The Master Guide

2026-2027 EDITION

FE MECHANICAL

REVIEW & PRACTICE

INCLUDES ONLINE PREP

- Practice Problems with ILLUSTRATIONS & Solutions
- NAEX Private STUDY-GROUP with PEs Tutoring
- NCEES-Aligned Exam Simulator - CBT

NAEX Networking Alliance of Engineering Excellence | Samad Khan PE

ONLINE RESOURCES

CLICK HERE TO ACCESS THE PRACTICE PROBLEMS

CLICK HERE TO ACCESS THE EXAM SIMULATOR

CLICK HERE TO ACCESS THE STUDY-GROUP

You'll be taken to our Discord Server, where the resources are located.

Copyright - All Rights Reserved

© **NAEX Publishing - All rights reserved.** No part of this publication may be reproduced, stored in a retrieval system, or transmitted in any form or by any means (electronic, mechanical, photocopying, recording, or otherwise) without prior written permission of the copyright owner, except for brief quotations in reviews or scholarly works.

Independent Study Guide / NCEES Disclaimer

This publication is an **independent study guide** for the **NCEES FE Mechanical** exam. It is **not affiliated with, endorsed by, or sponsored by** the **National Council of Examiners for Engineering and Surveying (NCEES)**. The **FE Reference Handbook** is **copyrighted by NCEES**. This guide **does not reproduce** NCEES copyrighted **tables, figures, or text**. **NCEES** and **FE** are trademarks of NCEES; all trademarks belong to their respective owners.

Limited Warranty / Results Not Guaranteed

Limited Warranty and Results Disclaimer. Issued by **NAEX Publishing** ("We/Us/Our") and applies only to this study guide and related materials ("Materials"). We warrant only that the Materials were prepared in good faith and are intended to support FE Mechanical exam study. **No guarantee is made** that any user will pass the exam, achieve any specific score, or obtain licensure; outcomes depend on factors beyond our control (including prior knowledge, study time, test conditions, and exam changes). Any examples, testimonials, or score references are **illustrative only** and not a promise of results.

Limitation of Liability. To the maximum extent permitted by law, the Materials are provided **"as is"** and we disclaim all other warranties (express or implied). We are not liable for any indirect, incidental, special, or consequential damages arising from use of (or inability to use) the Materials.

Severability. If any provision is found unenforceable, the remaining provisions remain in effect.

TABLE OF CONTENTS

KNOWLEDGE 01 14

MATHEMATICS 14

TOPIC 01 - ANALYTIC GEOMETRY 15

K01.T01.S01 – Lines and Distances 15
K01.T01.S02 – Quadratics and Basic Algebraic Geometry 17
K01.T01.S03 – Polar Coordinates and Complex Plane Representations 19
K01.T01.S04 – Mensuration of Areas and Volumes ... 21
K01.T01.S05 – Conic Sections (Ellipse, Parabola, Hyperbola Classification) 24

TOPIC 02 - CALCULUS 27

K01.T02.S01 – Differential Calculus (Single-Variable Derivative Rules & Applications) 27
K01.T02.S02 – Integral Calculus (Single-Variable Integration Techniques & Applications) 29
K01.T02.S03 – Series and Expansions (Taylor Series) 33
K01.T02.S04 – Multivariable Calculus Basics (Partial Derivatives, Gradients, Multiple Integrals, Core Concepts) 35

TOPIC 03 - ORDINARY DIFFERENTIAL EQUATIONS 39

K01.T03.S01 – Formulation and Solutions of Linear ODEs (Homogeneous and Particular Solutions) 39
K01.T03.S02 – Solutions of Constant-Coefficient ODEs (Characteristic Equations for Common Forms) 40
K01.T03.S03 – Transform Methods for ODEs (Use of Laplace Transforms to Solve ODEs) 42

TOPIC 04 - LINEAR ALGEBRA 46

K01.T04.S01 – Matrix Operations (Addition & Multiplication) 46
K01.T04.S02 – Matrix Determinant 47
K01.T04.S03 – Matrix Inverse 48
K01.T04.S04 – Solving Linear Systems (using Determinants: Cramer's Rule) 50
K01.T04.S05 – Dot Product of Vectors (Scalar Product) 52
K01.T04.S06 – Cross Product of Vectors (Vector Product) 53
K01.T04.S07 – Vector Projections and Components 55

TOPIC 05 - NUMERICAL METHODS 58

K01.T05.S01 – Accuracy and Precision, Significant Figures & Rounding 58
K01.T05.S02 – Error and Uncertainty Propagation in Calculations 59
K01.T05.S03 – Series Approximations of Functions (Taylor Series & Truncation Error) 61
K01.T05.S04 – Root-Finding and Optimization Methods (Newton–Raphson Method) 64

TOPIC 06 - ALGORITHM AND LOGIC DEVELOPMENT 68

K01.T06.S01 – Algorithm Building Blocks (Sequence, Selection, Iteration) & Flowcharts 68
K01.T06.S02 – Pseudocode Writing and Interpretation for Program Logic 70

KNOWLEDGE 02 75

PROBABILITY & STATISTICS 75

TOPIC 01 - PROBABILITY DISTRIBUTIONS 76

K02.T01.S01 – Fundamental Probability Distribution Functions (Discrete & Continuous) 76
K02.T01.S02 – Common Distribution Types (Binomial, Normal, Uniform, Exponential) 77
K02.T01.S03 – Empirical Distributions (Terminology and Concept) 80

TOPIC 02 - MEASURES OF CENTRAL TENDENCY AND DISPERSION 83

K02.T02.S01 – Measures of Central Tendency (Mean, Median, Mode) 83
K02.T02.S02 – Measures of Dispersion (Range, Variance, Standard Deviation) 85
K02.T02.S03 – Confidence Intervals and Margin of Error (Estimates of Mean/Proportion) 88

TOPIC 03 - EXPECTED VALUE IN DECISION MAKING 92

K02.T03.S01 – Definition of Expected Value (Discrete & Continuous Random Variables) 92
K02.T03.S02 – Linearity of Expectation (Sums of Random Variables & Decision Criteria) 94

TOPIC 04 - REGRESSION, CURVE FITTING, AND GOODNESS OF FIT 98

K02.T04.S01 – Simple Linear Regression (Least Squares Fit) 98
K02.T04.S02 – Multiple Linear Regression (Model & Coefficients) 100
K02.T04.S03 – Linear Correlation Coefficient (r) and Coefficient of Determination (R^2) 103

K02.T04.S04 – Basics of Curve Fitting and Model Adequacy 107
K02.T04.S05 – Goodness-of-Fit Metrics (R^2) 110

KNOWLEDGE 03 114

ETHICS AND PROFESSIONAL PRACTICE 114

TOPIC 01 - CODES OF ETHICS 115

K03.T01.S01 – Fundamental Canons of Engineering Ethics 115

TOPIC 02 - PUBLIC HEALTH, SAFETY, AND WELFARE 118

K03.T02.S01 – Engineer's Professional Obligation to Protect Public Health, Safety, and Welfare 118
K03.T02.S02 – Ethical and Legal Responsibilities to Report or Mitigate Unsafe Practices 119
K03.T02.S03 – Role of Regulations, Standards, and Codes in Safeguarding the Public Interest 122

TOPIC 03 - ETHICS AND PROFESSIONAL PRACTICE: INTELLECTUAL PROPERTY 125

K03.T03.S01 – Definition and Categories of Intellectual Property 125
K03.T03.S02 – Patents, Trademarks, and Copyright: Protections & Basics 125
K03.T03.S03 – Confidentiality and Trade Secrets in Engineering Projects 127

TOPIC 04 - SOCIETAL CONSIDERATIONS 129

K03.T04.S01 – Principles of Sustainable Development in Engineering Design 129
K03.T04.S02 – Environmental & Social Impact Considerations (Life-Cycle Analysis) 130
K03.T04.S03 – Broader Social Implications of Engineering Solutions (Global, Economic, Environmental Facets) 131

KNOWLEDGE 04 135

ENGINEERING ECONOMICS 135

TOPIC 01 - TIME VALUE OF MONEY 136

K04.T01.S01 – Present, Future & Annual Worth (Single Sums & Uniform Series) 136
K04.T01.S02 – Nominal vs Effective Interest Rates (Non-Annual Compounding) 138
K04.T01.S03 – MARR Concept & Real vs Nominal Interest (Inflation-Adjusted Rates) 140
K04.T01.S04 – Using Standard Interest Factor Tables (P/A, A/F, P/G, etc.) 143

TOPIC 02 - COST TYPES AND BREAKDOWNS 147

K04.T02.S01 – Types of Costs: Fixed, Variable, Direct, Indirect, Capital, Operating 147
K04.T02.S02 – Incremental Cost, Average Cost, and Sunk Cost 148
K04.T02.S03 – Categories of Cost Estimates (Order-of-Magnitude, Budget, Definitive) 149

TOPIC 03 - ECONOMIC ANALYSES 151

K04.T03.S01 – Breakeven Analysis & Simple Payback Period 151
K04.T03.S02 – Benefit–Cost Analysis (B/C Ratio) 153
K04.T03.S03 – Life-Cycle Costing (Including Operation & Maintenance Costs) 154
K04.T03.S04 – Equivalent Annual Cost (EAC) for Alternatives 156
K04.T03.S05 – Present Worth and Future Worth Analyses (Discounted Cash Flows) 158
K04.T03.S06 – Internal Rate of Return (IRR) and Minimum Attractive Rate of Return (MARR) 160
K04.T03.S07 – Economic Analysis of Overhead 162

KNOWLEDGE 05 165

ELECTRICITY AND MAGNETISM 165

TOPIC 01 - ELECTRICAL FUNDAMENTALS 166

K05.T01.S01 – Basic Electrical Units and Quantities 166
K05.T01.S02 – Ohm's Law and Electrical Power 167
K05.T01.S03 – Magnetic Flux 168
K05.T01.S04 – Characteristics of Resistors, Capacitors, and Inductors 169

TOPIC 02 - DC CIRCUIT ANALYSIS 172

K05.T02.S01 – Kirchhoff's Laws (KCL and KVL) 172
K05.T02.S02 – Series and Parallel Combinations (Resistances & Sources); Network Simplification 174
K05.T02.S03 – Thévenin's and Norton's Equivalent Circuits 178
K05.T02.S04 – DC Power and Energy in Circuits 182

TOPIC 03 - AC CIRCUIT ANALYSIS 186

K05.T03.S01 – Sinusoidal Signal Characteristics & Phasor Representation 186
K05.T03.S02 – Impedance and Admittance in AC Circuits 188
K05.T03.S03 – Power Factor and Correction 190

TOPIC 04 - MOTORS AND GENERATORS 194

K05.T04.S01 – Principles of Electromechanical Energy Conversion 194
K05.T04.S02 – AC Machines: Synchronous Speed & Slip 196

KNOWLEDGE 06 201

STATICS 201

TOPIC 01 - RESULTANTS OF FORCE SYSTEMS 202

K06.T01.S01 – Vector Addition of Forces in Two Dimensions (Resultant Force) 202
K06.T01.S02 – Moment of a Force About a Point and Equivalent Force–Couple Systems 203

K06.T01.S03 – Reduction of Distributed Loads into Resultants (Uniform Load Resultant) 205
K06.T01.S04 – Equilibrium Requirements for General Force Systems (Net Force and Net Moment = 0) 207

TOPIC 02 - CONCURRENT FORCE SYSTEMS 210

K06.T02.S01 – Concurrent Forces (Definition) 210
K06.T02.S02 – 2D Equilibrium Equations for Concurrent Forces 211
K06.T02.S03 – Relationship between Resultants and Equilibrium in Concurrent Systems 212

TOPIC 03 - EQUILIBRIUM OF RIGID BODIES 215

K06.T03.S01 – Conditions for Rigid-Body Equilibrium in a Plane 215
K06.T03.S02 – Free-Body Diagrams and Static Equilibrium for Structures and Machines 217
K06.T03.S03 – Support Reactions for Various Supports (Pins, Rollers, Fixed) 219

TOPIC 04 - FRAMES AND TRUSSES 224

K06.T04.S01 – Planar Truss Analysis (Method of Joints) 224
K06.T04.S02 – Planar Truss Analysis (Method of Sections) 225
K06.T04.S03 – Determinacy and Stability of Plane Trusses 226
K06.T04.S04 – Classification of Supports and Determinacy 228

TOPIC 05 - CENTROIDS AND MOMENTS OF INERTIA 229

K06.T05.S01 – Determining Centroids of Areas, Lines, and Volumes 229
K06.T05.S02 – Area Moments of Inertia (Ix, Iy) and Composite Areas 230
K06.T05.S03 – Parallel-Axis Theorem (Transferring I to a Parallel Axis) 231
K06.T05.S04 – Using Standard Shape Tables for Centroids and Inertia 233

TOPIC 06 - STATIC FRICTION 235

K06.T06.S01 – Coulomb's Model of Dry Friction (Static Friction) 235
K06.T06.S02 – Belt Friction (Capstan Equation) 236
K06.T06.S03 – Threaded Screw Friction (Power Screw Torque) 237

KNOWLEDGE 07 241

DYNAMICS, KINEMATICS, AND VIBRATIONS 241

TOPIC 01- KINEMATICS OF PARTICLES 242

K07.T01.S01 – Kinematic Quantities for Particle Motion: Displacement, Velocity, Acceleration (Functions of Time) 242
K07.T01.S02 – Motion in Cartesian (Rectangular) Coordinates (e.g. Projectile Motion) 243
K07.T01.S03 – Motion in Planar Polar Coordinates (Radial and Transverse Components) 245
K07.T01.S04 – Special Cases of Particle Motion: Rectilinear Motion and Uniform Circular Motion 246
K07.T01.S05 – Normal and Tangential Acceleration Components for Curvilinear Motion (Radius of Curvature Concepts) 248
K07.T01.S06 – Relative Motion of Particles Using Translating or Rotating Reference Axes (Relative Velocity and Acceleration in Moving Frames) 251

TOPIC 02 - KINETIC FRICTION 254

K07.T02.S01 – Kinetic Friction Force (Sliding Friction) 254

TOPIC 03 - NEWTON'S SECOND LAW FOR PARTICLES 257

K07.T03.S01 – Application of $\sum F = ma$ for Particle Motion in One and Two Dimensions 257
K07.T03.S02 – Solving Dynamics Problems in Normal–Tangential Coordinates or Cartesian Coordinates Using $F = ma$ 259
K07.T03.S03 – Incorporating Weight ($W = mg$) and Other Forces into Equations of Motion for Particles 263

TOPIC 04 - WORK–ENERGY 269

K07.T04.S01 – Work–Energy Principle for Particles (Work Done = Change in Kinetic Energy) 269
K07.T04.S02 – Kinetic Energy of a Particle and Gravitational Potential Energy 271
K07.T04.S03 – Conservation of Energy in Conservative Systems (Mechanical Energy Conservation) 275
K07.T04.S04 – Power and Efficiency in Work–Energy Calculations 277

TOPIC 05 - IMPULSE–MOMENTUM 282

K07.T05.S01 – Linear Impulse–Momentum Theory 282
K07.T05.S02 – Angular Momentum of a Particle & Angular Impulse–Momentum 284
K07.T05.S03 – Impact and Collision Analysis (Elastic & Inelastic Collisions) 286

TOPIC 06 - KINEMATICS OF RIGID BODIES 291

K07.T06.S01 – Pure Rotation about a Fixed Axis (Angular Kinematics) 291
K07.T06.S02 – Instantaneous Center of Zero Velocity (Planar Motion) 292
K07.T06.S03 – Relative Velocity and Acceleration in a Rotating Rigid Body 294
K07.T06.S04 – Mass Moment of Inertia and Parallel-Axis Theorem 297

TOPIC 07 - KINEMATICS OF MECHANISMS 301

K07.T07.S01 – Velocity and Acceleration in Slider-Crank Mechanisms 301

TOPIC 08 - NEWTON'S SECOND LAW FOR RIGID BODIES 307

K07.T08.S01 – Equations of motion for planar rigid bodies 307
K07.T08.S02 – Dynamics of rigid bodies in plane motion (combined translation + rotation) 309

TOPIC 09 - WORK–ENERGY OF RIGID BODIES 312

K07.T09.S01 – Kinetic Energy of a Rigid Body in Plane Motion 312
K07.T09.S02 – Work–Energy Principle Applied to Rigid Bodies 313
K07.T09.S03 – Work–Energy in Pure Rotation (Work of a Moment) 315

TOPIC 10 - IMPULSE–MOMENTUM 318

K07.T10.S01 – Linear Impulse–Momentum (Rigid Body Center of Mass) 318
K07.T10.S02 – Angular Impulse–Momentum (Rigid Body Rotation) 320
K07.T10.S03 – Conservation of Momentum in Collisions (Impulsive Forces & No External Moments) 323

TOPIC 11 - FREE AND FORCED VIBRATIONS 327

K07.T11.S01 – Free Vibration of SDOF Systems (Natural Frequency) 327
K07.T11.S02 – Damped Vibration Cases (Damping Ratio & Response Types) 328
K07.T11.S03 – Forced Harmonic Vibration (Resonance & Steady-State Response) 329

KNOWLEDGE 08 332

MECHANICS OF MATERIALS 332

TOPIC 01 - SHEAR AND MOMENT DIAGRAMS 333

K08.T01.S01 – Sign Conventions for Internal Shear Forces and Bending Moments 333
K08.T01.S02 – Differential Relationships: Load wx, Shear Vx, and Moment Mx 334
K08.T01.S03 – Construction of Shear and Bending Moment Diagrams for Beams 336

TOPIC 02 - STRESS TRANSFORMATIONS AND MOHR'S CIRCLE 341

K08.T02.S01 – Plane Stress Transformation (Stresses on an Inclined Plane) 341
K08.T02.S02 – Principal Stresses & Maximum Shear (2D) 342
K08.T02.S03 – Mohr's Circle for Plane Stress (Graphical Method) 344
K08.T02.S04 – Yield Criteria under Combined Stress (von Mises, Tresca, Mohr's Theory) 345

TOPIC 03 - STRESS AND STRAIN CAUSED BY AXIAL LOADS 349

K08.T03.S01 – Uniaxial Stress–Strain Behavior and Hooke's Law 349
K08.T03.S02 – Axial Deformation of Members Under Load (Δ = PL/AE) 350
K08.T03.S03 – Thermal Strain in Members (Free Expansion and Induced Stress) 351
K08.T03.S04 – Generalized Linear Elasticity in 3D (E, G, n Relations & Thermal Strains) 353

TOPIC 04 - STRESS AND STRAIN CAUSED BY BENDING LOADS 356

K08.T04.S01 – Flexural (Bending) Stress in Beams 356
K08.T04.S02 – Transverse Shear Stress in Beams 357
K08.T04.S03 – Beam Deflection Equation and Integration Method (Euler–Bernoulli Beam Equation) 359
K08.T04.S04 – Use of Standard Beam Deflection Formulas and Tables for Common Loading Cases 361
K08.T04.S05 – Superposition Principle for Beam Deflections 364

TOPIC 05 - STRESS AND STRAIN FROM TORSIONAL LOADS 367

K08.T05.S01 – Torsional Shear Stress in Circular Shafts 367
K08.T05.S02 – Angle of Twist in Shafts 369
K08.T05.S03 – Shear Strain Distribution in Solid vs. Thin-Walled Shafts 371

TOPIC 06 - STRESS AND STRAIN CAUSED BY SHEAR 375

K08.T06.S01 – Shear Stress–Strain Relationship (Modulus of Rigidity) 375
K08.T06.S02 – Transverse Shear in Beams (Shear Stress Distribution & Shear Flow) 377
K08.T06.S03 – Sign Conventions for Internal Shear Forces in Beams 379

TOPIC 07 - STRESS AND STRAIN CAUSED BY TEMPERATURE CHANGES 382

K08.T07.S01 – Free Thermal Expansion (Unrestrained) 382
K08.T07.S02 – Thermal Stress from Restrained Expansion (Fully Fixed) 383
K08.T07.S03 – Thermal Strain in Combined Loading (Statically Indeterminate Scenarios) 385
K08.T07.S04 – Including Thermal Effects in Deflection Calculations 387

TOPIC 08 - COMBINED LOADING 389

K08.T08.S01 – Superposition of Stresses from Multiple Loads 389
K08.T08.S02 – Mohr's Circle for Combined Stress States (Principal Stresses) 390
K08.T08.S03 – Failure Criteria under Combined Stress (von Mises Yield Criterion) 392

K08.T08.S04 – Thin-Walled Pressure Vessels (Hoop & Longitudinal Stresses) 394

TOPIC 09 - DEFORMATIONS 397

K08.T09.S01 – Axial Deformations (Tension/Compression of Bars) 397
K08.T09.S02 – Torsional Deformations (Angle of Twist in Shafts) 399
K08.T09.S03 – Bending Deflections in Beams (Slope and Deflection of Beams) 403
K08.T09.S04 – Deflection due to Thermal Loads (Thermal Expansion in Structures) 407

TOPIC 10 - COLUMN BUCKLING 413

K08.T10.S01 – Euler Buckling Load & Effective Length Factor 413
K08.T10.S02 – Euler's Formula Assumptions & Limitations 414

TOPIC 11 - STATICALLY INDETERMINATE SYSTEMS 417

K08.T11.S01 – Planar Truss Determinacy Criterion 417
K08.T11.S02 – Planar Frame Determinacy Criterion 418
K08.T11.S03 – Single-Redundancy Force Method (Compatibility Equation) 420

KNOWLEDGE 09 424

MATERIAL PROPERTIES AND PROCESSING 424

TOPIC 01 - PROPERTIES 425

K09.T01.S01 – Chemical Properties and Corrosion 425
K09.T01.S02 – Electrical Properties (Permittivity, Capacitance, Resistivity, Conductivity) 426
K09.T01.S03 – Mechanical Properties: Stress–Strain (Definitions, Young's Modulus E, Shear Modulus G, Poisson's Ratio n) 427
K09.T01.S04 – Shear Stress–Strain and Elastic Constants (Relations Between E, G, and n) 430
K09.T01.S05 – Fracture Toughness (K_1C) and Material Resistance to Crack Propagation 432
K09.T01.S06 – Brinell hardness → UTS rule-of-thumb (steels) 435
K09.T01.S07 – Physical & Thermal Properties: Density, Thermal Conductivity, Coefficient of Thermal Expansion, Thermal Diffusivity 437
K09.T01.S08 – Using Material Property Tables for Design 440

TOPIC 02 - STRESS-STRAIN DIAGRAMS 444

K09.T02.S01 – Engineering Stress–Strain Curve Key Points 444
K09.T02.S02 – Engineering vs. True Stress–Strain Curves 445
K09.T02.S03 – Elastic vs. Plastic Deformation and Young's Modulus (Strain Hardening Behavior) 448

TOPIC 03 - FERROUS METALS 451

K09.T03.S01 – Iron–Iron Carbide (Fe–C) Phase Diagram 451
K09.T03.S02 – Thermal Treatment of Steel: Martensite vs. Pearlite Formation 451
K09.T03.S03 – Mechanical Properties of Plain Carbon Steels vs. Alloy Steels 453
K09.T03.S04 – Common Ferrous Alloys: Carbon Steel, Stainless Steel, Cast Iron 455

TOPIC 04 - NONFERROUS METALS 458

K09.T04.S01 – Properties of Common Nonferrous Metals 458
K09.T04.S02 – Typical Uses and Characteristics of Nonferrous Metals 459
K09.T04.S03 – Reference Tables of Nonferrous Metal Properties 461

TOPIC 05 - ENGINEERED MATERIALS 463

K09.T05.S01 – Composite Materials: Fiber-Reinforced Composites 463
K09.T05.S02 – Polymer Materials: Thermoplastics vs. Thermosets 464
K09.T05.S03 – Other Advanced Materials: Ceramics and Their Properties 466

TOPIC 06 - MANUFACTURING PROCESSES 469

K09.T06.S01 – Overview of Manufacturing Processes for Metals 469
K09.T06.S02 – Thermal and Mechanical Processing of Metals (Cold-Working vs. Hot-Working) 470
K09.T06.S03 – Heat Treating Processes: Annealing, Normalizing, Quenching, Tempering 472

TOPIC 07 - PHASE DIAGRAMS, PHASE TRANSFORMATIONS, AND HEAT TREATING 475

K09.T07.S01 – Binary Phase Diagrams & Lever Rule 475
K09.T07.S02 – Eutectic & Eutectoid Transformations 476
K09.T07.S03 – Cooling Rate & Microstructure (Pearlite vs. Bainite vs. Martensite) 477
K09.T07.S04 – Case Hardening Processes (Carburizing & Nitriding) 478

TOPIC 08 - MATERIALS SELECTION 481

K09.T08.S01 – Criteria for Selecting Materials for Engineering Design 481
K09.T08.S02 – Comparative Material Properties Charts & Performance Indices (Ashby Charts) 482
K09.T08.S03 – Material Selection for Specific Environments 483
K09.T08.S04 – Examples of Material Trade-offs (Aluminum vs. Steel, Composites vs. Metals) 484

TOPIC 09 - CORROSION MECHANISMS AND CONTROL 487

K09.T09.S01 – Common Corrosion Mechanisms 487

K09.T09.S02 – Electrochemical Nature of Corrosion 488
K09.T09.S03 – Methods of Corrosion Control 490
K09.T09.S04 – Environmental Effects and Material Compatibility 493

TOPIC 10 - FAILURE MECHANISMS 496

K09.T10.S01 – Thermal Failure: Creep Deformation & High-Temperature Rupture 496
K09.T10.S02 – Fatigue Failure: S–N Curves, Endurance Limit & Influencing Factors 497

KNOWLEDGE 10 501

FLUID MECHANICS 501

TOPIC 01 - FLUID PROPERTIES 502

K10.T01.S01 – Density, Specific Weight, Specific Volume, Specific Gravity 502
K10.T01.S02 – Viscosity (Dynamic & Kinematic) and Fluid Shear Stress 503
K10.T01.S03 – Pressure as a Fluid Stress (Pressure at a Point) 504
K10.T01.S04 – Surface Tension and Capillarity 506
K10.T01.S05 – Using Standard Fluid Property Tables (Water and Other Fluids) 507

TOPIC 02 - FLUID STATICS 510

K10.T02.S01 – Hydrostatic Pressure Distribution . 510
K10.T02.S02 – Manometers 512
K10.T02.S03 – Barometers 515
K10.T02.S04 – Hydrostatic Forces on Plane Surfaces 517
K10.T02.S05 – Buoyancy (Archimedes' Principle) 522

TOPIC 03 - ENERGY, IMPULSE, AND MOMENTUM IN FLUIDS 526

K10.T03.S01 – One-Dimensional Energy Equation (Bernoulli's Equation, No Losses) 526
K10.T03.S02 – Energy Grade Line (EGL) and Hydraulic Grade Line (HGL) 527
K10.T03.S03 – Euler's Equation (Differential Bernoulli Equation for Inviscid Flow) 529
K10.T03.S04 – Impulse–Momentum Principle for Fluid Flow (Control Volume Form of Newton's 2nd Law) 531
K10.T03.S05 – Forces from Momentum Change in Applications (Bends, Nozzles, and Jet Impingement) 533

TOPIC 04 - INTERNAL FLOW 536

K10.T04.S01 – Darcy–Weisbach Head Loss (Fully Developed Pipe Flow) 536
K10.T04.S02 – Friction Factor and Moody Chart (Laminar vs Turbulent Flow) 538
K10.T04.S03 – Minor Losses in Pipes (Valves, Bends, Fittings) 540
K10.T04.S04 – Hydraulic Diameter for Noncircular Conduits 542
K10.T04.S05 – Pipe Network Basics (Series, Parallel, and Pump Head) 544

TOPIC 05 - EXTERNAL FLOW 547

K10.T05.S01 – Drag Force 547
K10.T05.S02 – Drag Coefficient & Reynolds Number (Common Shapes) 548
K10.T05.S03 – Lift vs. Drag (Force Orientation and Applications) 550
K10.T05.S04 – Boundary Layer Concepts (Laminar vs. Turbulent Flow over Surfaces) 552

TOPIC 06 - COMPRESSIBLE FLOW 554

K10.T06.S01 – Mach Number and Flow Regimes 554
K10.T06.S02 – Isentropic Flow Relations (Stagnation & Area–Mach) 555
K10.T06.S03 – Normal Shock Relations 557
K10.T06.S04 – Choked Flow in Nozzles 558

TOPIC 07 - POWER AND EFFICIENCY 561

K10.T07.S01 – Pump Power and Efficiency 561
K10.T07.S02 – Gas Compressor Work (Adiabatic vs. Isothermal) 562
K10.T07.S03 – Turbine Power and Isentropic Efficiency 564
K10.T07.S04 – Fans and Blowers (Low-Pressure Air Movers) 567

TOPIC 08 - PERFORMANCE CURVES 569

K10.T08.S01 – Characteristic Performance Curves of Centrifugal Pumps 569
K10.T08.S02 – System Curve and Pump Operating Point 570
K10.T08.S03 – Fan Performance Curves and Affinity Laws 572

TOPIC 09 - SCALING LAWS FOR FANS, PUMPS, AND COMPRESSORS 574

K10.T09.S01 – Affinity Laws for Turbomachinery (Fans, Pumps, Compressors) 574
K10.T09.S02 – Dimensionless Parameters and Similarity (Reynolds Number Scaling) 576
K10.T09.S03 – Model Testing and Prototype Performance Prediction 579

KNOWLEDGE 11 583

THERMODYNAMICS 583

TOPIC 01 - PROPERTIES OF IDEAL GASES AND PURE SUBSTANCES 584

K11.T01.S01 – Thermodynamic State Variables and Units 584
K11.T01.S02 – Ideal Gas Law and Assumptions 585
K11.T01.S03 – Specific Heats for Ideal Gases (c_p, cv) and Mayer's Relation 586

K11.T01.S04 – Phase Change in Pure Substances (Saturation and Quality) 588
K11.T01.S05 – Thermodynamic Property Diagrams and Phase Regions 590
K11.T01.S06 – Thermodynamic Property Tables (Steam Tables Usage) 591
K11.T01.S07 – Ideal Gas Mixtures and Partial Pressures 593

TOPIC 02 - ENERGY TRANSFERS 596

K11.T02.S01 – First Law of Thermodynamics (Closed System) 596
K11.T02.S02 – Steady-Flow Energy Equation (Open System) 597
K11.T02.S03 – Special Steady-Flow Devices (Nozzles, Throttles, Pumps/Fans) 600
K11.T02.S04 – Transient Energy Analysis Basics (Unsteady Systems) 602

TOPIC 03 - LAWS OF THERMODYNAMICS 605

K11.T03.S01 – First Law of Thermodynamics (Energy Conservation) 605
K11.T03.S02 – Second Law of Thermodynamics (Entropy & Irreversibility) 606
K11.T03.S03 – Entropy Change for Reversible Processes (Entropy as a Property) 609
K11.T03.S04 – Isentropic Process (Reversible Adiabatic Process) 611

TOPIC 04 - PROCESSES 615

K11.T04.S01 – Boundary Work for Closed Systems 615
K11.T04.S02 – Flow Work in Open Systems 617
K11.T04.S03 – Specific Processes: Isobaric, Isochoric, Isothermal, Adiabatic, Polytropic 618
K11.T04.S04 – Entropy Change for Common Processes 621
K11.T04.S05 – Steady-Flow Device Processes (Nozzles, Turbines, Pumps, Heat Exchangers) 623

TOPIC 05 - PERFORMANCE OF COMPONENTS 627

K11.T05.S01 – Nozzles and Diffusers 627
K11.T05.S02 – Turbines, Pumps, and Compressors 628
K11.T05.S03 – Heat Exchangers 630
K11.T05.S04 – Refrigeration Components (Evaporator, Condenser, Expansion Valve) 633

TOPIC 06 - POWER CYCLES 636

K11.T06.S01 – Heat Engine Cycles & Thermal Efficiency 636
K11.T06.S02 – Carnot Cycle as Ideal Benchmark 637
K11.T06.S03 – Common Thermodynamic Power Cycles (Rankine, Brayton, Otto, Diesel) 639
K11.T06.S04 – Regenerative & Reheat Cycles (Improving Rankine Efficiency) 643

TOPIC 07 - REFRIGERATION AND HEAT PUMP CYCLES 646

K11.T07.S01 – Coefficient of Performance (COP) 646
K11.T07.S02 – Vapor-Compression Refrigeration Cycle 647
K11.T07.S03 – Refrigerants and Property Tables/Charts 649
K11.T07.S04 – Heat Pump Cycle (Heating Mode and Sources) 651

TOPIC 08 - NONREACTING MIXTURES OF GASES 654

K11.T08.S01 – Dalton's Law of Partial Pressures 654
K11.T08.S02 – Mixture Gas Constant and Specific Heats of Mixtures 655
K11.T08.S03 – Air–Water Vapor Mixtures (Psychrometrics Intro) 656

TOPIC 09 - PSYCHROMETRICS 659

K11.T09.S01 – Air–Water Vapor Mixture at 1 atm (Psychrometric Basics) 659
K11.T09.S02 – Humidity, Moisture Content, and Psychrometric Properties 660
K11.T09.S03 – Psychrometric Chart: Reading Moist Air State Points 662
K11.T09.S04 – Using Psychrometric Relationships (Evaporative Cooling & Saturation Calculations) 663

TOPIC 10 - HEATING, VENTILATION, AND AIR-CONDITIONING (HVAC) PROCESSES 665

K11.T10.S01 – Psychrometric Air Treatment Processes (Heating, Cooling, Humidification, Dehumidification, Mixing) 665
K11.T10.S02 – Heating/Cooling Load Calculations (Psychrometric Method) 666
K11.T10.S03 – Refrigeration & HVAC Cycles (Overview and Connection to Air Processes) 668

TOPIC 11 - COMBUSTION AND COMBUSTION PRODUCTS 671

K11.T11.S01 – Fuel Combustion Chemistry (Stoichiometric Combustion Equations) 671
K11.T11.S02 – Enthalpy of Combustion and Fuel Heating Values 673
K11.T11.S03 – First-Law Analysis of Combustion Processes (Energy Balance for Reactive Systems) 676

KNOWLEDGE 12 682

HEAT TRANSFER 682

TOPIC 01 - CONDUCTION 683

K12.T01.S01 – Fourier's Law of Heat Conduction 683
K12.T01.S02 – Steady 1D Conduction through Plane, Cylindrical, and Spherical Walls (Thermal Resistance Form) 685
K12.T01.S03 – Thermal Resistance Network Method (Composite Walls: Series & Parallel) 689
K12.T01.S04 – Extended Surfaces (Fins) Basics & Fin Efficiency/Effectiveness 691

TOPIC 02 - CONVECTION 696

K12.T02.S01 – Newton's Law of Cooling (Convective Heat Transfer) 696
K12.T02.S02 – External Flow Convective Correlations (Flat Plates & Cylinders) 698

TOPIC 03 - RADIATION 706

K12.T03.S01 – Stefan–Boltzmann Law & Emissivity (Blackbody Radiation Basics) 706
K12.T03.S02 – Radiative Surface Types (Black, Gray, and White Surfaces) 708

TOPIC 04 - TRANSIENT PROCESSES 711

K12.T04.S01 – Lumped-Capacitance Model for Transient Conduction 711
K12.T04.S02 – Time Constant & Exponential Temperature Response (Lumped Systems) 713

TOPIC 05 - HEAT EXCHANGERS 716

K12.T05.S01 – Types of Heat Exchangers (Parallel, Counterflow, Cross-flow, Shell-and-Tube) 716
K12.T05.S02 – Log Mean Temperature Difference (LMTD) Method for Heat Exchanger Analysis 717
K12.T05.S03 – Effectiveness–NTU Method for Heat Exchangers 720
K12.T05.S04 – Overall Heat Transfer Coefficient *U* for Composite Walls and Tubes 724
K12.T05.S05 – Fouling Factor Concept (Additional Resistance Due to Deposits) 727

KNOWLEDGE 13 730

MEASUREMENTS, INSTRUMENTATION, AND CONTROLS 730

TOPIC 01 - SENSORS AND TRANSDUCERS 731

K13.T01.S01 – Measurement Accuracy 731
K13.T01.S02 – Measurement Precision 731
K13.T01.S03 – Instrument Resolution 732
K13.T01.S04 – Transducer Sensitivity 732
K13.T01.S05 – Thermocouples (Seebeck Effect) 733
K13.T01.S06 – Thermocouple Types and Ranges (Table) 734
K13.T01.S07 – Resistance Temperature Detectors (RTDs) 735
K13.T01.S08 – Thermistors (NTC) 736
K13.T01.S09 – Strain Measurement: Strain Gauges & Wheatstone Bridges 737
K13.T01.S10 – Manometers 738
K13.T01.S11 – Bourdon Tube Gauge 739
K13.T01.S12 – Piezoelectric Pressure Transducers 740
K13.T01.S13 – Transducer (Sensor) Definition 741
K13.T01.S14 – Signal Conditioning (Gain & Filtering) 741
K13.T01.S15 – Sampling Theorem (Nyquist Sampling) 742
K13.T01.S16 – Aliasing (Definition) 742
K13.T01.S17 – A/D Conversion Resolution 743

TOPIC 02 - CONTROL SYSTEMS 744

K13.T02.S01 – Block Diagram of Feedback Control System 744
K13.T02.S02 – Open-Loop vs Closed-Loop Control Systems 746
K13.T02.S02 – Unity Feedback Control Systems 747

TOPIC 03 - DYNAMIC SYSTEM RESPONSE 749

K13.T03.S01 – First-Order System Response 749
K13.T03.S02 – Second-Order System Response (Underdamped Mass–Spring–Damper or RLC) 750

TOPIC 04 - MEASUREMENT UNCERTAINTY 754

K13.T04.S01 - Significant Figures in Calculations and Reporting 754
K13.T04.S02 – Measurement Uncertainty and Error Propagation 755
K13.T04.S03 – Accuracy vs. Precision (ISO Definitions) 755
K13.T04.S04 – Significant Figures and Rounding 756
K13.T04.S05 - Measurement Errors: Systematic vs Random 757
K13.T04.S06 - Propagation of Uncertainty (Kline–McClintock) 758
K13.T04.S07 - Significant Figures and Rounding 759
K13.T04.S08 – Measurement Uncertainty (Definition) 759
K13.T04.S09 – Accuracy and Precision (Definitions) 760
K13.T04.S10 – Uncertainty Propagation (Kline–McClintock Equation) 761
K13.T04.S11 – Significant Figures (Reporting Rules) 762

KNOWLEDGE 14 764

MECHANICAL DESIGN AND ANALYSIS 764

TOPIC 01 - STRESS ANALYSIS OF MACHINE ELEMENTS 765

K14.T01.S01 – Shafts and Axles (Static Loading) 765
K14.T01.S02 – Shafts and Axles (Fatigue Loading) 766
K14.T01.S03 – Bearing Loads and Life Calculation 769

TOPIC 02 - FAILURE THEORIES AND ANALYSIS 773

K14.T02.S01 – Static Failure Theories for Brittle Materials (Max Normal Stress & Mohr's Theory) 773
K14.T02.S02 – Static Failure Theories for Ductile Materials (Tresca & Von Mises Yield Criteria) 775
K14.T02.S03 – Fatigue Failure Criteria under Combined Loading (Mean & Alternating Stress) 778
K14.T02.S04 – Endurance Limit for Steels and Modification Factors 782

TOPIC 03 - DEFORMATION AND STIFFNESS 787

K14.T03.S01 – Axial Deformation of Members (Tension/Compression) 787

K14.T03.S02 – Torsional Deformation (Angle of Twist in Shafts) 788
K14.T03.S03 – Beam Deflection in Machine Elements (Bending) 789
K14.T03.S04 – Superposition of Deflections (Combined Loading) 791

TOPIC 04 - SPRINGS 793

K14.T04.S01 – Helical Spring Constant & Deflection 793
K14.T04.S02 – Spring Geometry & End Conditions (Effects on k and Solid Height) 794

TOPIC 05 - PRESSURE VESSELS AND PIPING 797

K14.T05.S01 – Thin-Walled Cylindrical Vessels (Hoop & Longitudinal Stress) 797
K14.T05.S02 – Thin-Walled Spherical Vessels (Uniform Membrane Stress) 799

TOPIC 06 - BEARINGS 801

K14.T06.S01 – Bearing Life Analysis 801
K14.T06.S02 – Bearing Selection Considerations 802

TOPIC 07 - POWER SCREWS 805

K14.T07.S01 – Torque to Raise a Load (Square-Thread Screw) 805
K14.T07.S02 – Self-Locking Condition for Power Screws 807
K14.T07.S03 – Power Screw Efficiency and Collar Friction 808
K14.T07.S04 – Torque to Lower a Load (and Effect of Thread Friction) 811

TOPIC 08 - POWER TRANSMISSION 814

K14.T08.S01 - Shafts and keys 814
K14.T08.S02 - Gears and gear trains 814
K14.T08.S03 - Belt and chain drives 815
K14.T08.S04 - Belt friction (capstan equation) 815

TOPIC 09 - JOINING METHODS 817

K14.T09.S01 – Threaded Fasteners (Bolts and Screws) 817
K14.T09.S02 – Bolted Joint Failure Modes 818
K14.T09.S03 – Welding 819
K14.T09.S04 – Adhesive Bonding 820

TOPIC 10 - MANUFACTURABILITY 821

K14.T10.S01 – Tolerances and Fits 821
K14.T10.S02 – Hole Basis vs Shaft Basis Systems 821
K14.T10.S03 – Geometric Tolerances (GD&T Basics) 821
K14.T10.S04 – Design for Manufacturability 822

TOPIC 11 - QUALITY AND RELIABILITY 823

K14.T11.S01 – Statistical Quality Control: Control Charts 823
K14.T11.S02 – Process Capability Indices (Cp, Cpk) 824
K14.T11.S03 – Reliability Basics (Definition, Failure Rate, MTBF) 825
K14.T11.S04 – System Reliability (Series vs. Parallel) 826

TOPIC 12 - COMPONENTS 828

K14.T12.S01 – Hydraulic Power Components 828
K14.T12.S02 – Basic Pneumatics 829
K14.T12.S03 – Mechanism Components 830
K14.T12.S04 – Electromechanical Drives 831
K14.T12.S05 – Sensors and Actuators in Mechatronics 832

TOPIC 13 - ENGINEERING DRAWING INTERPRETATION AND GEOMETRIC DIMENSIONING & TOLERANCING 834

K14.T13.S01 – Standard Drawing Conventions: Orthographic Projections, Sections, Dimensioning 834
K14.T13.S02 – GD&T Form Tolerances (Straightness, Flatness, Circularity, Cylindricity) 834
K14.T13.S03 – GD&T Orientation Tolerances (Parallelism, Perpendicularity, Angularity) 835
K14.T13.S04 – GD&T Location Tolerances (Position, Concentricity) 835
K14.T13.S05 – GD&T Runout Tolerances (Circular Runout, Total Runout) 836
K14.T13.S06 – GD&T Profile Tolerances (Profile of a Line, Profile of a Surface) 837
K14.T13.S07 – Definitions: Datum, Feature of Size, MMC and LMC Modifiers 837
K14.T13.S08 – Interpreting Feature Control Frames 838
K14.T13.S09 – Reading Assembly Drawings and Fits: Clearance vs. Interference 838

DON’T START YET!

Join the **FE Mechanical Study Group** before you dive in.

The group keeps you **accountable, on schedule, and moving forward** with people preparing for the same exam.

STAY ON TRACK UNTIL TEST DAY

CLICK HERE TO JOIN THE GROUP

You’ll be taken to our Discord Server, where you can meet other FE students, follow the weekly pace, ask questions, and stay motivated.

KNOWLEDGE 01

MATHEMATICS

- NAEX Publishing -

"This publication is not affiliated with or endorsed by NCEES".

Topic 01 - Analytic Geometry

Analytic geometry is the study of geometric objects using a coordinate system and algebraic principles. In the context of the FE Mechanical Exam, analytic geometry provides essential tools for solving spatial problems – from calculating distances and slopes in a structural layout to determining areas and volumes of components. Mastering these formulas and concepts is crucial on exam day because many mechanical engineering problems boil down to geometry: you might be asked to find the distance between two points in a diagram, the volume of a tank, or interpret an equation of a curve (like a circle or parabola) that models a physical boundary. Typical question archetypes include: - Computing the straight-line distance or midpoint between two given coordinate points (think locating supports or connections). - Using the slope of a line to examine parallel or perpendicular alignments (for example, checking if two members are orthogonal). - Converting between Cartesian and polar coordinates for force vectors or complex impedance (common in dynamics or controls contexts). - Calculating areas of cross-sections or volumes of standard shapes (e.g. plate areas, vessel volumes). - Classifying a given second-degree equation as an ellipse, parabola, or hyperbola – ensuring you recognize the geometry behind an equation. The following subtopics break down the key principles, formulas, and problem-solving "moves" in analytic geometry that are **most relevant to the FE Mechanical Exam**. By the end of this chapter, you'll have a clear, at-a-glance reference ("passport") for each formula or concept, an understanding of when and how to use it, and insight into common exam pitfalls to avoid. Let's dive in!

K01.T01.S01 – Lines and Distances

Principle Introduction (Lines & Distances):

- A **straight line** in a plane can be described by linear equations. The most exam-useful forms are the slope–intercept form $y = mx + b$ and point–slope form $y - y_1 = m(x - x_1)$. These forms make it easy to identify a line's slope m and intercept or to write the equation if you know a point and slope.

- **Slope** m represents the steepness and direction of a line: $m = \frac{\Delta y}{\Delta x} = \frac{y_2 - y_1}{x_2 - x_1}$. A positive slope means the line rises to the right, a negative slope means it falls to the right, zero slope is a horizontal line, and an undefined slope (division by zero) is a vertical line.

- **Parallel lines** have the same slope. **Perpendicular lines** have slopes that are negative reciprocals, meaning $m_1 m_2 = -1$. This criterion is commonly used to confirm that axes or parts are orthogonal in mechanical drawings.

- The **distance formula** gives the shortest distance (straight-line) between two points $P_1(x_1, y_1)$ and $P_2(x_2, y_2)$ in the plane. It's derived from the Pythagorean theorem by treating the differences in x and y as legs of a right triangle. This formula is key for finding lengths, such as the distance between supports, the length of a link in a mechanism, or the diagonal of a plate.

- Intuition: If the horizontal separation is $\Delta x = x_2 - x_1$ and vertical separation is $\Delta y = y_2 - y_1$, the distance is the hypotenuse of a right triangle with those side lengths. Thus, expect a square-root-of-sum-of-squares structure.

Visual: Below is a diagram of two points P_1 and P_2 on the Cartesian plane, illustrating the components used in the distance formula. The differences Δx and Δy form the legs of a right triangle, and the direct distance d is the hypotenuse.

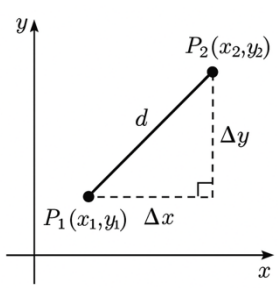

Two points $P_1(x_1, y_1)$ and $P_2(x_2, y_2)$ with a right triangle illustrating Δx, Δy, and the distance d between them. The line's slope $m = \frac{\Delta y}{\Delta x}$ and the distance $d = \sqrt{(\Delta x)^2 + (\Delta y)^2}$.

Exam Handbook Search Cues (Not affiliated with or endorsed by NCEES): straight line, slope-intercept, point-slope, distance between two points, perpendicular line slope.

Equation Passport – Distance Between Two Points (2D Cartesian)
Name and purpose: Distance Formula – computes the straight-line distance d between two points in the plane. Useful for finding lengths of components or spacing in coordinate problems.

Equation (Cartesian plane):

$$d = \sqrt{(x_2 - x_1)^2 + (y_2 - y_1)^2}$$

Variables and units:

- d – distance between points $P_1(x_1, y_1)$ and $P_2(x_2, y_2)$; same length units as the coordinates (e.g. m, ft).
- x_1, x_2 – x-coordinates of the two points (length units).
- y_1, y_2 – y-coordinates of the two points (length units).
- (All coordinates must be in the **same** unit system for d to be meaningful.)

Assumptions and scope:
- Applies to **straight-line distance** in a flat 2D plane (Cartesian coordinates).
- Assumes a standard Euclidean metric (ordinary geometry) – which is always the case in FE problems unless explicitly stated otherwise.
- Can be extended to 3D space as $d = \sqrt{(x_2 - x_1)^2 + (y_2 - y_1)^2 + (z_2 - z_1)^2}$ if a problem involves three-dimensional coordinates. (Most FE Mechanical questions remain in 2D, but keep 3D in mind for completeness.)

Limit tests (sanity checks):
- If the points coincide ($x_2 = x_1$ and $y_2 = y_1$), then $\Delta x = \Delta y = 0$ and $d = 0$. This checks out: zero separation means zero distance.
- If the points differ only along one axis (say $y_2 = y_1$, so horizontal line), then $d = |x_2 - x_1|$ (just the absolute difference in x), which makes sense for purely horizontal separation (and similarly $d = |y_2 - y_1|$ for vertical separation).
- As Δx or Δy grows very large, d grows proportionally – there's no weird behavior, it's a straightforward length.

Use vs. sibling equations: Use this formula instead of breaking a distance into components or doing iterative steps – it directly gives the shortest path length. For path distances that aren't straight lines (e.g. along axes), other calculations (like sum of absolute

differences) would be used, but for direct point-to-point distance, **always use the distance formula** over any "Manhattan" distance or approximations.

Common exam traps:

- **Unit mix-ups:** Ensure x and y differences are in the same units before squaring and adding. If one point is given in feet and another in inches, convert to a single unit system first.

- **Dropping the square root:** It's easy to compute $(\Delta x)^2 + (\Delta y)^2$ and forget the square root. Remember d is a length, not its square.

- **Sign mistakes:** Squaring will eliminate sign, so it doesn't matter which point is "first" or "second" – order won't affect the result. Just be careful when plugging into your calculator; use parentheses to avoid squaring errors.

- **Interpreting $m = \frac{\Delta y}{\Delta x}$ vs. distance:** Slope is *not* the same as distance. A common mix-up is to confuse the two formulas. Slope gives a ratio, distance gives an actual length. If the question asks for length, use the distance formula (with square root), not the slope formula.

Footnotes:

- It's good practice to draw the difference triangle as in the figure when applying the distance formula. This helps prevent mistakes and also double-checks any given coordinates visually.

- The distance formula reflects the Pythagorean theorem. A quick mental check: distances are always non-negative, and a larger difference in either axis should increase the distance.

- In the exam-approved calculators, you can compute d in one step. For example, on the TI-36X Pro, you might use the sequence: $\sqrt{((x2 - x1)^2 + (y2 - y1)^2)}$ directly. Just take care with parentheses. On the Casio fx-991, you could store Δx and Δy in memory or use the multi-line display for the sum inside the root.

Variations and related forms:

- **Midpoint formula:** Since distance is often paired with midpoints, recall that the midpoint M between P_1 and P_2 has coordinates $M\left(\frac{x_1+x_2}{2}, \frac{y_1+y_2}{2}\right)$. This isn't directly in the distance formula, but it's another straight-line geometry tool if the exam asks for a point location halfway.

- **Line length in 3D:** As noted, $d = \sqrt{(\Delta x)^2 + (\Delta y)^2 + (\Delta z)^2}$ extends the distance concept to three dimensions. If you ever need the distance between two spatial points (say, two corners of a rectangular box in a statics problem), this extension is your friend.

- **Distance from a point to a line:** A different formula (not the two-point distance) gives the shortest distance from a point to a given line. While not explicitly listed in our outline, it's worth noting: for a line $Ax + By + C = 0$ and a point (x_0, y_0), the perpendicular distance is $\frac{|Ax_0+By_0+C|}{\sqrt{A^2+B^2}}$. This might come up if you need the distance of a point from a reference line. Keep this in your back pocket, but it's not as commonly tested as the point-to-point distance.

Special notes:

If using the FE Exam on-screen **calculator**, remember to use the square root and squaring functions carefully. For instance, if you have large or awkward numbers, break it down: calculate $(x_2 - x_1)$ and $(y_2 - y_1)$ first, square each, add them, then square root. This reduces the chance of a typo in a long expression. Naming this process as a quick move – e.g., *"the two-point distance move: subtract, square, sum, root"* – can speed you up under pressure.

Explanation & Analysis (Step-by-Step):

What is it used for? In FE-style problems, the distance formula is used whenever you need a straight-line length between two coordinate-defined points. This could be finding the length of a member in a truss given end coordinates, the distance between two holes on a plate, or the diagonal distance a projectile travels in the xy-plane. Essentially, if the problem provides two points (or you can infer them) and asks "how far apart are these?", you'll use this formula. It's also the backbone for finding perimeters of polygons, distances in centroid calculations, and more.

Basic idea: Think of the coordinate differences $\Delta x = x_2 - x_1$ and $\Delta y = y_2 - y_1$. These represent how far you move horizontally and vertically to get from P_1 to P_2. To get the direct distance, you form a right triangle. The distance d is the hypotenuse, so by Pythagoras: $d^2 = (\Delta x)^2 + (\Delta y)^2$. Taking the positive square root yields the distance. It's straightforward: you're combining the horizontal and vertical separations into one oblique distance.

Term-by-term analysis:

- $(x_2 - x_1)^2$: The squared horizontal separation. Squaring makes it positive and appropriately weights larger gaps more heavily.
- $(y_2 - y_1)^2$: The squared vertical separation. Similarly positive and scale-sensitive.
- Summation: $(x_2 - x_1)^2 + (y_2 - y_1)^2$ is the sum of squared legs of the triangle – effectively d^2. This sum has units of length² (e.g. m² if input in m).
- Square root: $\sqrt{\ }$ brings the units back to length (meters, feet, etc.) and gives the final magnitude of separation.

Notice there is no term for cross-product of $\Delta x \Delta y$ – distance formula only cares about the orthogonal contributions. This means movements in x and y are "independent" in terms of contributing to distance (a key property of perpendicular axes). If either difference is zero, the distance purely comes from the other difference. If both differences are nonzero, each contributes via the sum of squares.

Common mistakes and pitfalls in use:

- **Forgetting to take a square root**: Students sometimes stop at d^2. Always remember that distance is d, not d^2. If you find yourself with a huge number and no square root, double-check.

- **Calculator entry errors**: If you input the whole formula at once, be mindful of parentheses. For example, if you type $\sqrt{(x2 - x1)^2} + (y2 - y1)^2$, most calculators will only take the square root of $(x_2 - x_1)^2$ and then add $(y_2 - y_1)^2$. To avoid this, either add extra parentheses: $\sqrt{(x2 - x1)^2 + (y2 - y1)^2}$ or break it into steps.

- **Mixing up slope vs distance**: A slope calculation might be needed in the same problem. Keep them conceptually separate: slope is a ratio (no units, or units of y over units of x), distance is an absolute length. For example, given two points you might have to find both the slope of the line through them and the distance between them. Solve slope with the division formula, distance with the root formula – don't confuse one for the other.

K01.T01.S02 – Quadratics and Basic Algebraic Geometry

Principle Introduction (Quadratics & Basic Shapes):

- **Quadratic equations** and curves form the basis of many geometric shapes. In analytic geometry, "quadratic" refers to second-degree polynomial equations in either one variable (like $ax^2 + bx + c = 0$) or two variables (like $x^2 + y^2 + Dx + Ey + F = 0$). Mechanical exam problems may involve recognizing or using the properties of these curves.

- The **standard quadratic formula** (for one variable) is a tool for solving for roots: given $ax^2 + bx + c = 0$, the solutions are

$$x = \frac{-b \pm \sqrt{b^2 - 4ac}}{2a}$$

While this purely algebraic result isn't a geometric principle by itself, it often underpins finding intercepts of curves or intersection points of lines and circles/parabolas. It's considered fundamental knowledge (and likely not listed explicitly in the exam reference, since examinees are expected to know it). Use it whenever you need to find where a quadratic function equals zero (e.g., solve for x when $y = 0$ or vice versa).

- **Circles and parabolas** are classic quadratic-plane figures:

A **circle** is defined as the set of points equidistant from a center. Its standard equation (in Cartesian form) is $(x - h)^2 + (y - k)^2 = r^2$, representing a circle of radius r centered at (h, k). Expanding or rearranging this yields a general form $x^2 + y^2 + Dx + Ey + F = 0$. Recognizing this form allows you to read off the center and radius by completing the square if needed. For example, $x^2 + y^2 - 6x + 4y - 3 = 0$ can be rewritten as $(x^2 - 6x) + (y^2 + 4y) = 3$, then $(x - 3)^2 - 9 + (y + 2)^2 - 4 = 3$, so $(x - 3)^2 + (y + 2)^2 = 16$; thus center $(-3, -2)$ and radius 4.

A **parabola** is a curve such that every point on it is equally distant from a fixed point (the focus) and a fixed line (the directrix). In algebraic terms, a vertical parabola with vertex at (h, k) can be given by $(y - k) = A(x - h)^2$ (if opening up/down) or $(x - h) = A(y - k)^2$ (if opening right/left). The most familiar form is $y = ax^2 + bx + c$, which describes a parabola opening upward if $a > 0$ or downward if $a < 0$. Key features: the vertex (turning point) occurs at $x = -b/(2a)$ for $y = ax^2 + bx + c$, and the parabola is symmetric about the vertical line through the vertex. On the FE exam, you might be asked about the vertex or intercepts of a parabolic trajectory or shape – knowing how to get these quickly is valuable.

- **Basic algebraic geometry** often means knowing the equations for simple shapes: lines (covered above), circles, and parabolas (here), and sometimes ellipses or hyperbolas (next subtopic). It also includes understanding how to manipulate these equations: e.g., given an equation, identify the shape or its parameters (radius, center, etc.).

- Intuition: Circles are "nice" in that they look the same in all directions (no preferred axis) – their equation has x^2 and y^2 terms with the same coefficient when centered at the origin. Parabolas are direction-sensitive (one axis is squared, the other is not). Quadratic equations can often be visualized: if both x and y are squared and with the same sign, you get an ellipse or circle; if only one is squared, you get a parabola; if one is negative relative to the other, a hyperbola. In this subtopic, we focus on the circle and parabola as fundamental examples.

Exam Handbook Search Cues (Not affiliated with or endorsed by NCEES): circle equation, center, radius, parabola, quadratic formula, standard form, conic section.

Equation Passport – Circle (Standard Cartesian Equation)
Name and purpose: Circle Equation – represents all points (x, y) that lie on a circle of a given radius and center. Use it to identify a circle in an equation or to derive properties (radius, center coordinates) directly from the equation.

Standard Equation:

$$(x - h)^2 + (y - k)^2 = r^2$$

Variables and meanings:

- h, k – coordinates of the circle's **center**. (Units: same as x, y; often length units.)
- r – **radius** of the circle (distance from center to any point on the circle). (Units: same as x, y.)
- x, y – coordinates of any point on the circle's circumference. (Units: same baseline units.)

Assumptions and scope:
- This form assumes a circle in a standard Cartesian plane (not rotated – circles look the same even if "rotated", unlike ellipses, so no rotation issue here).

- The equation is derived from the definition of a circle: distance from (x, y) to center (h, k) is constant r. Essentially it's an application of the distance formula: $\sqrt{(x - h)^2 + (y - k)^2} = r$ squared on both sides leads to the equation.

- Valid for any circle. A **special case** is when the circle is centered at the origin $(0,0)$. Then $h = k = 0$ and the equation simplifies to $x^2 + y^2 = r^2$.

- Scope limitation: if $r = 0$, the "circle" collapses to a single point (the center). The formula still algebraically holds (all terms zero), but conceptually that's a degenerate case. Negative or imaginary r have no real meaning in geometry (they would imply no real points satisfy the equation).

Limit tests:

- As radius $r \to 0$, the circle shrinks to the center point. In the equation, $r^2 \to 0$, so it becomes $(x - h)^2 + (y - k)^2 = 0$ which indeed has the only solution $x = h, y = k$.

- As radius r grows large, the circle expands. No surprise in the equation except r^2 gets large. If $r \to \infty$, in a limiting sense the circle would appear as an infinitely large radius which is effectively a flat plane locally – but that's just a conceptual extreme, not used directly in problems.

- If you plug in a point (x, y) that is exactly r units away from (h, k), the equation balances. If the point is farther than r, the left side becomes greater than r^2 (indicating the point lies outside the circle); if closer, the left side is less (point inside). This can be a quick check: e.g., if asked whether a point lies inside a circle, plug it in – if $(x - x_c)^2 + (y - y_c)^2 < r^2$, it's inside; if $>$ it's outside; if $=$ it's exactly on the boundary.

Use vs. sibling equations: Use this equation for circles instead of trying to adapt from ellipse or other conic forms. **Do not confuse** with equations of ellipses or spheres:

- An **ellipse** has a similar looking equation $\frac{(x-h)^2}{a^2} + \frac{(y-k)^2}{b^2} = 1$, but with different denominators (radii along each axis). A circle is a special case of ellipse where $a = b = r$. If you see the same coefficient (or denominator) for x^2 and y^2, you have a circle. If they differ, it's a non-circular ellipse.

- A **sphere** in 3D is given by $(x-h)^2 + (y-k)^2 + (z-m)^2 = r^2$[8] – similar concept extended one dimension up. But on the exam, a sphere's equation might appear in a conceptual question about geometry in space, whereas circles are for plane geometry problems or cross-sections.

- Parabolas and hyperbolas look quite different (only one squared term or a subtraction between squared terms, respectively). If both x^2 and y^2 are present and **added**, think circle or ellipse; if subtracted, think hyperbola; if only one squared, think parabola.

Common exam traps:

- **Sign errors for center coordinates:** The equation is $(x-h)^2 + (y-k)^2 = r^2$. Students often slip when reading off the center. For example, given $(x+3)^2 + (y-4)^2 = 25$, one might hastily say the center is $(+3, -4)$, but actually note the form: $x + 3$ is $x - (-3)$. So $h = -3$, $k = 4$. It should be center $(-3,4)$. The **signs are inverted** inside the parentheses relative to the actual coordinates. A good practice: set each parenthetical term to zero to find the coordinate: $x + 3 = 0 \Rightarrow x = -3$, $y - 4 = 0 \Rightarrow y = 4$. That gives the center directly.

- **Forgetting to take square roots when solving:** If you're solving for x or y from a circle equation, you'll often isolate one variable as $(x-h)^2 = r^2 - (y-k)^2$ and then say $x - h = \pm\sqrt{r^2 - (y-k)^2}$. Don't drop the $\pm$! A circle isn't a function $y = f(x)$ globally (it fails the vertical line test); any attempt to solve will yield two branches (upper and lower half, or left and right half if solving for x).

- **Mixing units for r and coordinates:** If a problem states a radius in one unit and coordinates in another, convert units first. For example, "a circle of radius 3 inches centered at (0.1 ft, 0.2 ft)" – convert radius to feet (3 inches = 0.25 ft) before writing the equation or plugging into it. Otherwise the equation's left side (in ft²) and right side (in in²) would be inconsistent.

- **Confusing diameter with radius:** Sometimes a question gives the diameter. Remember $d_{\text{diameter}} = 2r$. If a circle's equation is asked for or if checking a point, use r, not the full diameter. If they say "circle of diameter 10," then $r = 5$. A subtle trap can be plugging diameter into the equation thinking it's r. This will yield a wrong r^2.

Footnotes:

- The general expanded form of a circle is $x^2 + y^2 + Dx + Ey + F = 0$. You might encounter this in an exam question requiring you to **complete the square** to find the center and radius. Completing the square is a quick procedure: group $x^2 + Dx$ and $y^2 + Ey$ separately, make each a perfect square trinomial by adding and subtracting $(D/2)^2$ etc. It might be worth practicing once so you're not caught off guard if a question presents a circle in general form.

- A circle's equation in **polar coordinates** simplifies nicely: $r(\theta) =$ constant, if the circle is centered at the origin. (E.g., $x^2 + y^2 = R^2$ becomes simply $r = R$ in polar form – a horizontal line in polar coordinate graph.) If the circle is not at origin, polar gets more complicated and is usually not needed for FE exam purposes.

Variations, related forms, typical values:

- **Parabola standard form:** For contrast, recall a vertical parabola with vertex at (h, k) can be written as $y = a(x-h)^2 + k$. If it's the "basic" parabola $y = ax^2$ (vertex at origin), then a stretches or compresses it (and flips it if negative). The larger $|a|$ is, the "steeper" or narrower the parabola. Parabolas often appear in projectile motion (distance vs. time graphs) or as curves of cables (though technically those are catenaries, often approximated by parabolas). Typical FE questions might simply ask for the vertex: you can use $-b/(2a)$ for x-coordinate of vertex (for $y = ax^2 + bx + c$). The y-coordinate of the vertex is then $f\big(-b/(2a)\big)$. No need to derive focus or directrix in mechanical exam context unless explicitly asked – which is rare.

- **Circle circumference and area:** While not analytic geometry per se, it's fair to recall: circumference $= 2\pi r$, area $= \pi r^2$. If an exam question gives a circle's circumference or area and asks for something about the circle's equation or radius, you may need to invert those formulas to find r. For example, if area is given as 50 (units²), then $r = \sqrt{50/\pi}$ before plugging into $(x-h)^2 + (y-k)^2 = r^2$.

- **Intersections of lines and quadratics:** A typical algebraic geometry task is to find where a line and a curve intersect. This involves substituting the line equation into the quadratic curve's equation (circle or parabola) – resulting in a quadratic equation in one variable. You'd solve it using the quadratic formula. The number of real solutions (0, 1, or 2) indicates how many intersection points (none, tangent, or two intersections). Keep in mind if the discriminant $b^2 - 4ac$ goes negative, there is no real intersection (e.g. line missing a circle entirely). This could be a conceptual question: "does this line intersect the circle?" and you'd essentially check that discriminant.

Special notes (calculator usage): Modern FE calculators can solve quadratic equations using the formula or even have built-in polynomial solvers (the Casio fx-991 and TI-36X Pro, for instance, can solve for roots given coefficients). However, be cautious: those solvers give you the roots, not the work – if the problem is conceptual, you might need to interpret those roots (like one may be extraneous in context, or you might need to then find a corresponding other coordinate). Use the solver to avoid arithmetic mistakes, but still *understand* what the solutions mean. If you use a solver, double-check by plugging answers back into the original equations if time permits.

Explanation & Analysis (Applications):

This subtopic's knowledge helps in interpreting and manipulating the equations of basic shapes:

- **Circles on exam day:** You might face a question like *"Given the equation $x^2 + y^2 - 4x + 6y - 12 = 0$, find the radius"* or *"the smallest distance from the point (4,5) to this circle."* Here you need to identify the circle's center and radius by completing the square: it turns out to be $(x-2)^2 + (y+3)^2 = 25$ (center (2, -3), radius 5 in this hypothetical). Then you can answer follow-ups (radius is 5; distance from (4,5) to center minus radius, etc.). Another common use is when a circle represents a path or boundary and you need to check if a point or another shape intersects it.

- **Parabolas on exam day:** Often come up in projectile motion (from physics) or optimization (max/min) problems. For example, *"A ball is thrown such that its height vs. horizontal distance follows $y = -0.1x^2 + 2x + 3$. How far from the thrower does it hit the*

ground?" That's asking for the positive root of the quadratic when $y = 0$. You'd use the quadratic formula to find where the parabola crosses $y = 0$. Or *"What is the maximum height?"* – find the vertex of that parabola. So understanding parabolas helps in those scenarios even if it's not a pure math question.

Term-by-term analysis (for circle equation example):

Consider $x^2 + y^2 + Dx + Ey + F = 0$. This is an expanded circle (or possibly other conic if D, E differ). - $x^2 + y^2$: Both coordinates squared – signals a conic that's not a parabola. The fact they are added (and implicitly coefficients equal if it's a circle) is key. - $Dx + Ey$: The linear terms shift the center from the origin. D is related to the x-coordinate of center by $h = -D/2$, and E relates to $k = -E/2$. So those terms indicate the translation of the circle in the plane. If both are zero, the circle is centered at origin. - F: the constant term, which relates to the radius via $r^2 = h^2 + k^2 - F$ (after completing squares). It essentially sets the size once center is accounted for. - In a specific example, after completing square you might get something like $(x - 2)^2 + (y + 3)^2 = 16$. There the terms clearly show center (2, -3) and radius 4 (since $r^2 = 16$). Each term has a clear geometric meaning: squared terms for spread, linear for shift, constant for size offset.

Common pitfalls:

We touched on them but to reiterate in context:

- **Completing the square mistakes:** It's easy to slip a sign when halving coefficients or to forget to add the same value to both sides. Write neatly and check: $(x^2 - 4x)$ becomes $(x^2 - 4x + 4) - 4$, because you add and subtract 4 (since $(-4/2)^2 = 4$). The added 4 forms $(x - 2)^2$, the subtracted 4 goes to the other side or combines with F. Just be systematic.

- **Using symmetry incorrectly:** For parabolas, remember the symmetry is about a vertical line $x = h$ for $y = a(x - h)^2 + k$. If given a standard form $y = ax^2 + bx + c$, use $-b/(2a)$. Don't try to average the roots unless you *have* the roots – yes, the axis of symmetry is exactly midway between roots if you find them, which is a good check (since $-b/(2a)$ equals $(x_{\text{root1}} + x_{\text{root2}})/2$). If only one root (double root) then the vertex is on the x-axis etc.

K01.T01.S03 – Polar Coordinates and Complex Plane Representations

Principle Introduction (Polar & Complex):

- **Polar coordinates** are another way to specify a point in the plane by giving its distance from the origin and its angle, instead of using (x, y)coordinates. Any point can be described by (r, θ) where r is the radial distance from the origin and θ is the angle measured from the positive x-axis (often in radians, but degrees can be used consistently if specified). This is extremely useful in problems with symmetry about a point or involving rotation. Mechanical contexts include describing vectors (like forces or velocities) by magnitude and direction, or dealing with rotational systems.

- **Coordinate conversion:** To convert between **Cartesian (rectangular)** and **polar** coordinates, use the relationships:

$$x = r\cos\theta,\ y = r\sin\theta,\ r = \sqrt{x^2 + y^2}$$

(this comes straight from the distance formula, distance from origin to (x, y))

$$\theta = \arctan\left(\frac{y}{x}\right)$$

(with attention to the correct quadrant for θ). These allow you to switch back and forth. For example, if a problem gives a force as "10 N at 30° from horizontal," you can translate that to components $F_x = 10\cos 30°$, $F_y = 10\sin 30°$. Conversely, if you have components and need the magnitude and direction, use $r = \sqrt{F_x^2 + F_y^2}$ and $\theta = \arctan(F_y/F_x)$with adjustments for the quadrant (i.e., add 180° if F_x is negative, etc.).

- The **complex plane representation** ties directly into polar coordinates. A complex number $z = a + jb$ (with $j = \sqrt{-1}$, electrical engineering often uses j instead of i to avoid confusion with current) can be thought of as a point (a, b) in the plane, where a is the x-coordinate (real part) and b is the y-coordinate (imaginary part). In polar form, the same number is represented as $z = c\,\angle\theta$ or $re^{j\theta}$, where $c = |z| = \sqrt{a^2 + b^2}$ is the magnitude and $\theta = \arctan(b/a)$ is the angle.

- This is extremely handy in engineering, especially in AC circuit analysis or vibration problems: it allows multiplying and dividing complex numbers by simply adding or subtracting their angles and multiplying or dividing their magnitudes. For FE Mechanical, you might use complex numbers in contexts like phasor diagrams (if you dip into some basic dynamics or controls) or just as another way to solve 2D vector problems. It's less common than in electrical, but it's part of the math toolkit.

- **Euler's identity:** $e^{j\theta} = \cos\theta + j\sin\theta$[13]. This beautiful relation bridges the polar (exponential form) and rectangular form of complex numbers. While you likely won't need to derive it on the FE, recognizing something like $5e^{j60°}$ means a complex number with magnitude 5 and angle 60° could be useful. It implies the rectangular form $5(\cos 60° + j\sin 60°) = 5(0.5 + j0.866) = 2.5 + j4.33$.

- Intuition: Polar coordinates are like using a compass – you say "go out a certain distance, then turn by an angle." Rectangular coordinates are like grid directions – "go over, then up." Sometimes one is far easier than the other. For example, a point on a circle of radius 4 is trivial in polar: $r = 4$. In rectangular, it's something like $x^2 + y^2 = 16$. Conversely, the sum of two vectors given in polar might be easier to do in rectangular components. So fluency in converting is key. Complex numbers just piggyback on this concept by treating the x-axis as the real axis and the y-axis as the imaginary axis.

Exam Handbook Search Cues (Not affiliated with or endorsed by NCEES): polar coordinate system, rectangular to polar, $x = r\cos\theta$, complex number, Euler's identity, magnitude phase, $a + jb$.

Equation Passport – Polar/Rectangular Conversion & Complex Formulas
Name and purpose: Polar–Rectangular Conversion – translates coordinates between Cartesian (x, y) and polar (r, θ) forms, and similarly expresses complex numbers in magnitude-angle form. Critical for problems involving directions and angles, enabling you to move into whatever representation makes calculation easier.

Key Equations:

- **To Cartesian (from polar):** $x = r\cos\theta, y = r\sin\theta$.
- **To Polar (from Cartesian):** $r = \sqrt{x^2 + y^2}, \theta = \arctan\left(\frac{y}{x}\right)$ (then adjust θ to the proper quadrant).

- **Complex number forms:** $a + jb = c\,(\cos\theta + j\sin\theta) = c\,e^{j\theta}$, where $c = \sqrt{a^2 + b^2} = |a + jb|$ and $\theta = \arctan(b/a)$ (again, quadrant-aware).

Variables and units:

- x, y – rectangular coordinates (units of length, or in a vector context units of the vector components, e.g. N for force components).
- r – radial coordinate (same units as x, y). Must be non-negative by convention; if you get a negative r from calculation, you can add 180° (π radians) to θ and take r positive, to represent the same point.
- θ – angular coordinate. In pure math, it's unitless (radians or degrees). On the exam, angles may be given in degrees unless otherwise noted – but the reference handbook often uses radians by default in formulas. Always check which mode your calculator is in if you're computing trig values.
- a, b – real and imaginary parts of a complex number (could represent x and y components of something, e.g., $a = F_x, b = F_y$). Same units if representing a physical quantity, otherwise just numbers.
- j – imaginary unit (symbolic, no units; note $j^2 = -1$). Some disciplines use i, but on the FE exam either symbol might appear depending on context. Mechanical engineering problems rarely use complex i/j except possibly in vibrations, but it's part of general math.
  c – magnitude of complex number (same unit as a, b if they have one; otherwise just a positive real number).

Assumptions and scope:

- The formulas assume the standard orientation: $\theta = 0$ along positive x-axis, θ measured counter-clockwise. This is the convention used in the exam handbook and by most engineering fields (bearing angles in surveying are an exception, but that's civil-focused).

- $\theta = \arctan(y/x)$ is **multi-valued** due to the periodicity of tangent. The arctan function on calculators returns a principal value (typically $-90° < \arctan < 90°$ or $-\pi/2 \ll \pi/2$ in radians). You must add 180° (π radians) if x is negative (to move to the correct quadrant II or III), or add nothing if x is positive and simply adjust the sign if y is negative (for quadrant IV you might get a negative angle which is fine or convert it to a positive by adding 360° if you prefer). In short, **know your quadrants**: e.g., (-3, 3) should give $\theta = 135°$, not 45°.

- For complex exponentials, $e^{j\theta}$ implicitly assumes θ in radians if you were to expand using series, but since we typically use it as a formal representation, just treat θ as an angle measure (radians or degrees consistently). On the FE, if they show something like $e^{j\omega t}$, ωt is in radians.

Limit tests:

- If $r = 0$, then $x = 0, y = 0$ regardless of θ; the angle becomes indeterminate (any θ represents the same point at origin). That's expected: at the origin, direction has no meaning.
- If $\theta = 0°$ (or 0 rad), then $x = r, y = 0$. If $\theta = 90°$ ($\pi/2$ rad), then $x = 0, y = r$. These correspond to the point lying on the axes as a quick check (cos0 =1, sin0=0; cos90=0, sin90=1).
- For complex numbers: if $b = 0$ (pure real), then $c = |a|$ and $\theta = 0°$ if a is positive (or 180° if a is negative), meaning the complex number lies on the real axis. If $a = 0, b \neq 0$ (pure imaginary), then $c = |b|$ and $\theta = +90°$ for positive imaginary or -90° for negative imaginary, meaning on the imaginary axis. These edge cases match expectations.

Use vs. sibling equations: Use these conversion formulas instead of trying to derive relationships from scratch every time you change representations. For instance, **don't** try to memorize separate formulas for specific angles – rely on the general ones. This is your universal method to convert any vector or point.

- If working with **unit vectors**: note that $\hat{\imath} = (1,0)$ is $r = 1, \theta = 0°$ and $\hat{\jmath} = (0,1)$ is $r = 1, \theta = 90°$. You can resolve any unit vector in polar as $\hat{u} = \cos\theta\,\hat{\imath} + \sin\theta\,\hat{\jmath}$.

- If you are summing multiple vectors given in polar form, a sibling approach is to break each into x, y (rectangular) using these formulas, sum those components, then convert back if needed. There isn't really an alternative formula that bypasses conversion unless you draw a vector polygon and use law of cosines/sines; but that gets cumbersome beyond two vectors. Conversion is the way to go.

Common exam traps:

- **Degree vs Radian mode:** This is a *big* one. If you are computing something like $y = r\sin\theta$ on your calculator, ensure it's in degrees if θ given is degrees. The exam handbook might list formulas assuming radians (they often omit the degree symbol), but exam problems typically specify degrees for angles in context (except maybe pure math questions). Always double-check your calculator mode when switching between pure math and engineering contexts.

- **Forgetting to adjust arctan angle:** As mentioned, arctan can fool you. For example, if x is negative and y is positive, your calculator might give $\theta = -45°$ (which would actually correspond to a -45 in QIV) when the point is really in QII and angle should be 135°. A reliable method: use the built-in **atan2(y,x)** function if available (Casio and TI often have a way to get angle from complex or coordinate conversion directly). Or manually: if $x < 0$, add 180° to the arctan result. If $x > 0$ and $y < 0$, adding 360° to a negative result might be needed to express a positive angle measure.

- **Sign of imaginary unit:** In Euler form, $e^{j\theta} = \cos\theta + j\sin\theta$. If you mistakenly use a minus, $e^{-j\theta} = \cos\theta - j\sin\theta$, which is the complex conjugate (mirror across the real axis). Keep track of the sign in exponent – it matters. On the exam, if dealing with something like rotation direction, a positive angle might mean one direction (counterclockwise by convention) and negative the opposite.

- **Using polar on non-origin centers:** Polar coordinates as defined assume the reference origin. If you have to use polar for a point relative to some other origin, make sure to translate coordinates first. For example, if you need the polar angle of a point relative to another point (not the global origin), subtract the coordinates to shift the origin there, then apply conversion.

- **Complex vs polar context:** Sometimes an answer might be given in a form that looks like a complex number but is actually just point coordinates, or vice versa. For instance, "$3 + 4j$" could be interpreted as a complex number with magnitude 5 at ~53° angle, but if we're in a coordinate geometry context, it might just denote the point (3,4). Usually the presence of j or i signals a complex

number, but be aware of context to avoid overthinking. The exam will likely be clear, but keep your interpretations straight.

Footnotes:

- The exam reference often lists these under *Mathematics* as **Polar Coordinate System** and **Algebra of Complex Numbers.** You'll find the formulas exactly as given, possibly with j noted as imaginary unit. Knowing that those keywords will bring up the needed relationships can save you time. - In some mechanical problems (like alternating stress calculations, phasor forms in vibrations, or when dealing with angles in mechanics), converting to complex numbers and using Euler's formula might be a neat trick. For instance, if asked to prove some trig identity or to simplify an expression, Euler's identity can turn trigonometric algebra into polynomial-like algebra. But that's more of a math trick than a necessity for FE. Still, it showcases the power of the representation.

- **Calculator tip:** Many calculators allow input/output in polar form. E.g., on the TI-36X Pro, you can enter a complex number in polar by using angle symbol ($\angle$). On the Casio fx-115/991, you can switch a complex result between $a + bj$ and $r\angle\theta$ form. This can speed up working with phasors or vector sums – just be comfortable with the syntax before exam day (practice it!).

Variations and typical uses:

- **Relative motion:** Polar coordinates shine in problems where something rotates or where you naturally get an angle. Suppose a rod of length L is pinned at one end and sweeps an angle θ. The other end's coordinates are most directly given as $(L\cos\theta, L\sin\theta)$. That's a direct polar-to-rectangular use.

- **Integration in polar:** If you ever need to integrate over an area in polar coordinates (common in calculus or area moments, though in FE they might give formula), remember area element $dA = r\,dr\,d\theta$. That's beyond just conversion but worth noting as a polar coordinate nuance.

- **Complex arithmetic:** The product $z_1 z_2$ in rectangular form is messy (multiply out and combine like terms). In polar form, if $z_1 = r_1 e^{j\theta_1}, z_2 = r_2 e^{j\theta_2}$, then $z_1 z_2 = r_1 r_2 e^{j(\theta_1+\theta_2)}$[12]. You just multiply magnitudes and add angles. Similarly, division: divide magnitudes, subtract angles. If a problem involves, say, two harmonic motions or phasors being combined, polar form makes it addition of exponents – far simpler.

- **Vector resolution:** Any time you break a vector into components, you're using these formulas implicitly. Conversely, any time you compute a resultant vector's magnitude and direction from components, you're using them. Being systematic (write down $x = r\cos\theta, y = r\sin\theta$ etc.) can prevent error, especially if doing multiple vectors.

Explanation & Analysis:

In practice, decide which form (polar or rectangular) makes the problem easier: - If you need to **add** or **subtract** vectors, rectangular components are often easier (add x-parts together, y-parts together). Then convert to polar if the answer needs to be magnitude/angle.

- If you need to **multiply** or **divide** quantities that have directional meaning (like complex impedances, or perhaps combining two rotational transformations), polar might be easier because you can multiply magnitudes and add/subtract angles instead of FOILing out binomials.

- Recognize polar equations: a classic example is a **circle** $r =$ constant (as noted), or a line through origin $\theta =$ constant. If a problem gave something like $\theta = 45°$, that describes a line at 45° in polar (all points making 45° with the x-axis). Or $r\cos\theta = d$ actually represents a vertical line (converted to $x = d$). Understanding these can sometimes allow quick identification of shapes or relationships in problems.

- For the complex plane: mechanical engineers might encounter complex numbers in solving 2nd order differential equations (roots for damping), but the FE exam keeps it simpler. Perhaps the most likely use is if a problem expects you to manipulate something like $(3 + 4j)^2$ or find the magnitude of $5 - 12j$. The latter is straightforward $\sqrt{5^2 + (-12)^2} = 13$. Or maybe converting a phasor current or something to time domain. Keep in mind: magnitude of $a + jb$ is $\sqrt{a^2 + b^2}$, angle is $\arctan(b/a)$. Even if you never use complex numbers elsewhere, that's just the polar conversion again.

Common pitfalls recap:

- Always label your intermediate results when converting: e.g., find r (don't mix it up with one of the original coords), find initial $\alpha = \arctan(y/x)$, then adjust α to θ. This clarity can prevent giving, say, an answer that has the correct magnitude but an acute angle when it should be obtuse.

- Don't forget that sin and cos may result in irrational numbers (like $\sin 30° = 0.5$ which is fine, but $\cos 30° = 0.8660$ ...). On a multiple-choice exam, if the answer is left in symbolic form (like $5\sqrt{3}/2$ instead of 4.33), recognize those common values to ensure you match it. That's more a general tip, but it applies when converting components back to polar as well.
- If a complex number is given in a weird format (like $\frac{1}{2+j3}$), you may need to "rationalize" by multiplying numerator and denominator by the conjugate (2 - j3 in this case) to get a standard form. Or convert the denominator to polar to invert it easily. Just be prepared for basic complex algebra manipulations.

K01.T01.S04 – Mensuration of Areas and Volumes

Principle Introduction (Areas & Volumes):

- **Mensuration** refers to the measurement of geometric quantities like length, area, and volume. In the FE exam context, this translates to knowing the standard formulas for areas of common 2D shapes and volumes of common 3D solids. These are often needed in mechanical problems for calculating cross-sectional areas (for stress or flow), surface areas (for heat transfer or painting/coating problems), or volumes (for mass, density, or fluid storage calculations).

- Essentially, you should be able to recall or quickly find formulas for: - Areas: triangle, rectangle, parallelogram, trapezoid, circle, ellipse, etc. - Volumes: rectangular prism (box), cylindrical shapes, spheres, cones, pyramids, etc. - Surface areas (especially of solids like cylinders, spheres) sometimes come into play, e.g., "wetted area" in a fluid problem or surface area for heat dissipation.

- The exam reference handbook provides a compilation of many of these formulas under a section typically titled "Mensuration of Areas and Volumes". While the exact compilation is extensive (covering even segments of circles, frustums, etc.), you should

focus on the basics unless a specialized shape pops up in a question. The nice thing: if you remember the names of shapes and general terms, you can quickly search that section during the exam.

- Intuition: These formulas often derive from simple geometry or calculus, but on exam day you're not deriving – you're recalling or referencing. For instance, the area of a circle πr^2 likely is ingrained in you. The volume of a cone $V = \frac{1}{3}\pi r^2 h$ is analogous to "cone is 1/3 of the cylinder with same base and height" which is a good way to remember it. Many volume formulas have a $1/3$ in them for pyramidal shapes. Many area formulas are basically base × height (like triangle, parallelogram) with a 1/2 factor for triangle. Noting these patterns can help avoid mixing them up.

Exam Handbook Search Cues (Not affiliated with or endorsed by NCEES): area formulas, volume formulas, mensuration, circle area, sphere volume, cylinder, cone, triangle area, pyramid volume.

Table: Common Geometric Areas and Volumes (with formulas and usage)

Shape	Formula – Area A Surface Area A_s	Formula – Volume V	Notes and Typical Use Cases
Rectangle (length L, width W)	$A = L \times W$.	– (2D shape, no volume)	Also square as special case $L = W$. Used for cross-sectional areas of plates, beams etc. Pitfall: trivial, just multiply sides (ensure same units).
Parallelogram (base b, height h)	$A = b \times h$.	–	Incl. rhombus (where all sides equal). Height is perpendicular distance between base lines. Often base*height like rectangle but height is not a side length if slanted.
Triangle (base b, height h)	$A = \frac{1}{2} b \times h$.	–	Applies to any triangle with known base and height. Height must be perpendicular to base. If using side lengths a, b, c, Heron's formula $A = \sqrt{s(s-a)(s-b)(s-c)}$ with $s = (a+b+c)/2$ is an alternative but rarely needed.
Trapezoid (parallel sides b_1, b_2, distance h between them)	$A = \frac{1}{2}(b_1 + b_2)\, h$.	–	Essentially average of parallel sides times height. Common for area under linear graph or cross-section of a tapered part.
Circle (radius r)	$A = \pi r^2$.	–	Extremely common: cross-sectional area of pipes, rods, etc. Circumference $= 2\pi r$. Pitfall: use radius, not diameter – if diameter d given, $A = \pi(d/2)^2 = \frac{\pi d^2}{4}$.
Ellipse (semi-axes a, b)	$A = \pi ab$.	–	If a and b are the "radius" along x and y (half the major and minor axis lengths). Circle is special case $a = b = r$. Rarely needed unless dealing with elliptical duct or stress area.
Sphere (radius r)	*Surface Area:* $A_s = 4\pi r^2$.	$V = \frac{4}{3}\pi r^3$.	Think of a sphere as a 3D circle: volume is $\frac{4}{3}$ of a cylinder πr^2 times r (roughly). Common use: volumes in tanks, planets, balls. Pitfall: leaving out the $\frac{4}{3}$ or using diameter in place of radius (remember to halve diameter!).
Right Circular Cylinder (radius r, height h)	*Surface Area:* $A_s = 2\pi rh + 2\pi r^2$. (side area $2\pi rh$ + top & bottom $2 \times \pi r^2$)	$V = \pi r^2 h$.	Cylinder is like an extruded circle: base area πr^2 times height. Very common (pipes, rods). If only lateral surface (side) area needed, use $2\pi rh$ (no caps). Pitfall: mixing radius vs diameter (again, $d = 2r$ so $V = \pi(d/2)^2 h = \frac{\pi d^2 h}{4}$).
Right Circular Cone (base radius r, height h)	*Surface Area:* $A_s = \pi r\ell + \pi r^2$. ($\ell$ = slant height = $\sqrt{r^2 + h^2}$, lateral area $\pi r\ell$ plus base πr^2)	$V = \frac{1}{3}\pi r^2 h$.	Volume is one third of corresponding cylinder. Appears in hopper, funnel volumes or pyramid analogies. Pitfall: ensure using height (perpendicular) not slant height in volume formula. Surface area formula provided if needed (less common in FE unless a coating problem).
Pyramid (base area A_b, height h)	*Surface Area:* (depends on each triangular face + base, generally $A_{\text{base}} + \sum A_{\text{faces}}$ – formula varies by shape)	$V = \frac{1}{3} A_b\, h$.	This covers any pyramid shape (square base, triangular base, etc.) as well as cones (a cone is essentially a circular-base pyramid). The volume

			being one third of base area times height is key. Used for e.g. volumes of berms, stacks, or tapered parts.
Rectangular Box (length L, width W, height H)	*Surface Area:* $A_s = 2(LW + LH + WH)$.	$V = L \times W \times H$.	A cuboid volume is straightforward. Surface area given in case needed (e.g. for heat loss calculations). Pitfall: just multiply all three for volume, don't confuse with perimeter formulas.
Prism/Prismoid (generic solid with uniform cross-section area A_b)	*Surface Area:* (depends on shape, often $2A_b +$ perimeter $\times H$ for side area)	$V = A_b \times H$. (if cross-section constant) For prismoid with two different parallel areas A_1, A_2: $V = \frac{H}{6}(A_1 + 4A_m + A_2)$ where A_m is mid-area.	Basically, volume of any prism = area of base * height, if the cross-section doesn't change. If it linearly changes from A_1 to A_2, use prismoidal formula (average areas with weight 4 on mid) – rarely needed explicitly unless a specific question on interpolation of volume.
Frustum of Cone/Pyramid (lower base area A_1, upper base area A_2, height h)	– (lateral area formula exists, but skip detail)	$V = \frac{h}{3}\left(A_1 + A_2 + \sqrt{A_1 A_2}\right)$.	A frustum is a "truncated" pyramid/cone (like a bucket shape). Know volume formula if needed, or derive by subtracting volumes of two cones/pyramids. Provided in handbook but not commonly tested unless they describe a tank shape.
Circular segment/sector	(Formulas are more complex – see handbook if needed)	–	Unlikely needed for mechanical FE unless computing area of fluid in a partially filled cylindrical tank. The handbook provides formulas. If such a scenario arises, recall: area of circular sector = $\frac{1}{2}r^2\phi$ (for angle ϕ in radians), and segment area = sector area minus triangular area. Possibly just refer to handbook if needed.

Typical exam moves:

- Use these formulas directly to compute areas/volumes. For example, *"What is the cross-sectional area of a beam with a diameter of 0.5 m?"* – you'd use $A = \pi r^2 = \pi(0.25)^2$. Or *"How much water (in cubic meters) can a cylindrical tank of radius 3 m and height 5 m hold?"* – $V = \pi(3^2)(5)$.

- In some cases, **combine shapes**: A complex object's volume might be broken into simpler parts. E.g., a capsule shape might be a cylinder plus two hemispheres. You'd compute cylinder volume + sphere volume (half of sphere for each end). Or area of an L-shape can be seen as sum/difference of rectangles. The ability to decompose shapes is useful.

- If computing **weight from volume**: first find volume (using these formulas), then multiply by material density. This often appears in mechanical problems (like find weight of a steel bar of given dimensions). So accuracy in volume is crucial for subsequent steps.

- **Interpolation and units**: The formulas assume consistent units for input dimensions. The output will be in the corresponding area or volume units (e.g., m², in³, etc.). If a question gives mixed units (rare, but say length in cm, width in m), convert to one system first. Also, be comfortable converting a volume result to other units (e.g., cubic feet to gallons, as sometimes asked in fluids).

Common pitfalls:

- **Unit consistency:** Already mentioned, but can't be overstated. If you plug $r = 3$ cm and $h = 2$ m into $V = \pi r^2 h$ without converting, you're mixing cm and m. Decide on one (e.g., convert r to 0.03 m). Many area/volume formulas will drastically mislead if units are off by even a factor of 100 (since area ~ length², volume ~ length³, unit mistakes blow up by squared or cubed factors!).

- **Choosing wrong formula:** For example, using the volume of a cylinder when the shape is a cone, or using area formula for the wrong shape. Carefully identify the shape: keywords like "right circular cone," "rectangular tank," "sphere," "diameter" etc., hint at which formula to pull. When in doubt, sketch the shape quickly to match it with a known formula.

- **Forgetting 1/3 in pyramidal volumes:** A very common slip is to treat a cone or pyramid as if it were a full prism. Always recall cones/pyramids have significantly less volume: exactly one third of the prism of equal base and height. The exam might even test that understanding conceptually (e.g., *"Compare the volume of a cone and cylinder with same base and height"* – answer: cone is 1/3).

- **Surface area vs cross-sectional area confusion:** If a problem asks for area to compute stress (force/area), they mean cross-sectional area (like the face area of a rod = circle area). If it asks for area for heat transfer (like area of a tank losing heat), they likely mean total surface area. Clarify which area is relevant. E.g., a pipe might have cross-sectional area for flow vs surface area for heat exchange. Use the right one.

- **Prismoid formula mishandling:** If you ever have to use $V = \frac{h}{6}(A_1 + 4A_m + A_2)$, ensure A_m is the area at mid-height (not the average of A_1, A_2 but area of actual cross-section halfway). This formula is built-in if shapes change linearly. However, if the shape isn't linearly transitioning (maybe curved sides), don't apply it blindly – but those are beyond FE usually.

- **Segments/sectors:** If a partial area of a circle is needed (like area of liquid in a horizontal pipe to a certain depth), the formula gets complicated. It's given in the handbook, but many times an approximate or logical approach can solve it too (or it might be multiple choice where you can identify the right expression). Just be cautious with angles in radians vs degrees in those formulas if you use them.

Footnotes:

- The FE Reference Handbook's mensuration section is comprehensive – likely more than you need. But it's organized by shape, which helps. If you search "Sphere", you'll find the sphere formulas. "Right Circular Cylinder" yields cylinder formulas. Use those cues in the exam if you don't recall a formula exactly.

- Some less common formulas: *Ellipsoid volume* $V = \frac{4}{3}\pi abc$ (if three different radii) – probably not needed in FE Mechanical, but just so you know it parallels sphere formula with three semi-axes. *Area of ellipse* we gave – seldom needed. *Surface area of cone* (given in table) – could be asked if, say, finding lateral surface for coating. It's $\pi r\sqrt{r^2 + h^2}$ for just the side (without base). Remember $\sqrt{r^2 + h^2}$ is slant height ℓ.

- **Volume of combined shapes:** one strategy – if a problem is oddly shaped, break it down. The exam isn't likely to require triple integrals or such; usually it can be split. E.g., "volume of a dome" might be half a sphere, so $V = 1/2\left(\frac{4}{3}\pi r^3\right) = \frac{2}{3}\pi r^3$. Or a "bar with a hole" – do outer volume minus inner cylindrical volume.

Variations and related topics:

- **Centroids and Moments of Inertia:** These often piggyback on area formulas. The location of a centroid of common shapes (triangle, semicircle, etc.) and second moment of area (area moment of inertia $I = \int y^2 dA$) for beams are related but separate topics. However, knowing areas precisely is step 1 in computing centroids or I for composite shapes. So, solidify area calcs to support those if needed.

- **Fluid volumes:** Sometimes volume formulas come in when calculating fluid weight or hydrostatic forces (like weight of water in a tank, requiring volume * density). Or in thermodynamics, volumes of vessels to use $PV = mRT$.

- **Surface area in heat transfer:** as mentioned, e.g., "fins have increased surface area to dissipate heat." The exam might throw a straightforward one: "Given dimensions of a fin, find its surface area." That's just using these formulas (area of rectangles + area of any cylindrical surfaces etc.).

Summary: Master these formulas: they are the bread-and-butter of mechanical calculations. They are easy points on the exam if you're comfortable with them. When in doubt, the exam's reference is your safety net, but speed comes from recognition. When you see a shape, the formula should almost reflexively pop up. Practice a few by doing quick calculations: e.g., the volume of a cone 10 cm high, 5 cm radius (should be ~261.8 cm³), or area of a trapezoid with bases 5 and 7 m, height 3 m (18 m²). This ensures you won't blank out under pressure.

K01.T01.S05 – Conic Sections (Ellipse, Parabola, Hyperbola Classification)

Principle Introduction (Conic Sections & Classification):

- **Conic sections** are the family of curves you get by cutting a cone with a plane – yielding ellipses (including circles), parabolas, or hyperbolas. In analytic terms, they correspond to second-degree equations in two variables x and y. Recognizing which type of conic a given equation represents can be useful for understanding the geometry of a problem. For example, the path of a projectile is parabolic, the cross-section of an optical reflector is parabolic, the loci of possible positions under certain constraints might form an ellipse or hyperbola, etc.

- The **general second-degree equation** for a conic is:

$$Ax^2 + Bxy + Cy^2 + Dx + Ey + F = 0,$$

with A, B, C not all zero (otherwise it degenerates to a line or point). Different conics have different characteristics of this equation. A quick classification test uses the **discriminant** $B^2 - 4AC$: - If $B^2 - 4AC < 0$: the equation represents an **ellipse** (if it's a real ellipse, also requires A and C have the same sign). A special case: if additionally $A = C$ and $B = 0$, it's a **circle**. Ellipses are closed curves (like squished circles).

- If $B^2 - 4AC = 0$: the equation represents a **parabola**. Parabolas are open curves with a single "branch" (U-shaped).
- If $B^2 - 4AC > 0$: the equation represents a **hyperbola**. Hyperbolas are open curves with two separate branches.
These criteria come from considering the equation in a rotated coordinate frame – but you don't need to derive it, just apply the test.

- **Orientation and rotation:** If $B \neq 0$, the axes of the conic are rotated relative to the coordinate axes, meaning the conic is tilted. If a problem presents a conic with an xy term, they might just want classification, not necessarily to find its foci or anything. If $B = 0$, the conic's axes are aligned with the x or y axes, making its equation easier (no cross term). For example, $x^2/9 + y^2/4 = 1$ is an aligned ellipse; xy term would complicate orientation.

- **Key parameters of each conic:**

- Ellipse: has major and minor axes lengths (2a, 2b), foci inside the ellipse. Equation in standard form $\frac{(x-h)^2}{a^2} + \frac{(y-k)^2}{b^2} = 1$. If $a = b$, it's a circle (all directions equal). Eccentricity $e < 1$.

- Parabola: has focus and directrix; standard form $(y-k)^2 = 4p(x-h)$ for a horizontal parabola or swap for vertical. Eccentricity $e = 1$.

- Hyperbola: has two branches, asymptotes, transverse axis length 2a, conjugate axis 2b; standard form $\frac{(x-h)^2}{a^2} - \frac{(y-k)^2}{b^2} = 1$ (horizontal opening) or swap x, y for vertical. Eccentricity $e > 1$.

- Eccentricity e is a measure of how "stretched" a conic is (0 for circle, 0<e<1 ellipse, =1 parabola, >1 hyperbola). It's defined as ratio of distance from focus to distance from directrix. The exam likely won't require computing e but might mention qualitatively.

In mechanical FE, direct use of conics is limited but could appear conceptually. For example, *"The path of a thrown object neglecting air resistance follows what curve?"* – a parabola. Or *"Given a general equation* $3x^2 + 2xy + 3y^2 = 12$*, identify the curve type."* – here $A = 3, B = 2, C = 3$, so $B^2 - 4AC = 4 - 36 = -32$, negative, and $A = C$ with $B \neq 0$ suggests an ellipse (rotated, since B not zero). Such a conceptual question can pop up in math sections.

- **Degenerate cases:** If the conic equation factors into linear factors, it's not an actual curve but two lines (or a repeated line). E.g., $x^2 -$

$y^2 = (x - y)(x + y)$ is two lines (so technically a hyperbola degenerated to lines). Or $x^2 + y^2 = 0$ has only solution (0,0) – a degenerate point. Usually, the exam won't trick with degenerate cases unless testing if you recognize when an equation doesn't represent a usual conic. But be aware: if the discriminant classification points to ellipse but the constants lead to, say, a negative radius squared, that means no real points (imaginary ellipse = no solution set). For instance, $x^2 + y^2 + 1 = 0$ has no real solution (no real circle). The handbook mentions things like if $a^2 + b^2 - c < 0$ locus is imaginary (meaning no real points). Just a footnote, not likely a focus on FE.

Exam Handbook Search Cues (Not affiliated with or endorsed by NCEES): conic section, B^2 - 4AC, ellipse, parabola, hyperbola, eccentricity.

Definition/Note Passport – Conic Classification by Discriminant

Definition: The value of $B^2 - 4AC$ in the general conic equation $Ax^2 + Bxy + Cy^2 + Dx + Ey + F = 0$ determines the type of conic section: - $B^2 - 4AC < 0$: an **Ellipse** (if A and C have the same sign) or **Circle** (special case $A = C, B = 0$).
- $B^2 - 4AC = 0$: a **Parabola** (the curve has a single degree of curvature; one squared term effectively, after rotation).
- $B^2 - 4AC > 0$: a **Hyperbola** (one positive and one negative squared term in some orientation).

(If the discriminant equals zero and also A or C is zero, it could be two parallel lines or one line – a degenerate parabola. If $B^2 - 4AC < 0$ but other conditions fail, e.g., A and C opposite sign, that actually gives a hyperbola – so the same sign condition for ellipse is important.)

Where it matters (exam impact): This classification mainly appears in mathematics problems. For FE Mechanical, you might use it to quickly identify the shape of a trajectory or the locus of points satisfying some property. Occasionally, a mechanical problem might involve an ellipse or hyperbola (e.g., stress-strain Mohr's circle is a circle actually; or cooling towers cross-section might approximate a hyperbola). But generally, expect a question in the pure math part like "Which of the following equations represents a hyperbola?" or a need to put an equation in standard form. Being able to classify ensures you know what kind of solution or behavior to expect (bounded vs unbounded, symmetric axes, etc.).

Pitfall or confusion point: A big confusion can be between ellipse vs hyperbola when looking at an equation. The negative sign difference is key. For example $4x^2 + 9y^2 = 36$ (both positive) is an ellipse; $4x^2 - 9y^2 = 36$ (one negative term) is a hyperbola. Parabolas show up typically as only one squared variable. Also, remember the circle as a special ellipse – sometimes problems ask specifically about a circle; identify $x^2 + y^2$ form. And don't misinterpret a rotated conic: xy term presence means the axes are rotated, but classification via discriminant still works.

Micro-check: True or False: The equation $x^2 + 4xy + y^2 = 0$ represents an ellipse.

(Take $A = 1, B = 4, C = 1$; compute $B^2 - 4AC = 16 - 4 = 12$, which is >0, so it's a hyperbola. Though it might factor to $(x + y)^2 + 2xy = (x + y)^2 + 2xy$ hmm not obvious, but the test says hyperbola. So the statement is False.)

Now, beyond classification, a brief note on each conic's analytic form for completeness:

Equation Passport – Standard Forms of Conics (Aligned with Axes)

(We present these to recall shape properties; use them when needed to extract details like vertices or foci. You might not need to memorize all foci formulas, but recognizing standard forms is useful.)

- **Ellipse (center at (h,k)):** $\frac{(x-h)^2}{a^2} + \frac{(y-k)^2}{b^2} = 1$.
  Variables: $a =$ semi-major axis (radius along x from center), $b =$ semi-minor axis (radius along y), assuming $a \geq b$. The major axis length is $2a$, minor $2b$. If $a = b$, it reduces to $\frac{(x-h)^2+(y-k)^2}{a^2} = 1$, a circle of radius a.
  Foci: located along major axis, at distance c from center, where $c^2 = a^2 - b^2$ (for ellipse $c < a$). So foci at $(h \pm c, k)$ for a horizontal major axis. Eccentricity $e = c/a$.

  Uses: Ellipses aren't that common in mechanical except maybe orbital paths (gravitation is not ME domain) or some optical/mechanical linkage shapes. Possibly in cooling fins or gear tooth profiles (not really though). Unlikely heavy use in FE exam beyond math.
  Trap: Don't confuse $a^2 - b^2$ here (ellipse) vs hyperbola (where $c^2 = a^2 + b^2$).

- **Parabola (vertex at (h,k)):** $y - k = A(x - h)^2$ (opens up/down) or $x - h = A(y - k)^2$ (opens right/left).
  Parameter: $p = \frac{1}{4A}$ if in the form $y - k = A(x - h)^2$.
  The focus will be at $(h, k + p)$ and directrix $y = k - p$ for an upward opening parabola. Essentially, $4p$ is the coefficient denominator if you rewrite $y - k = \frac{1}{4p}(x - h)^2$.

  Uses: Path of projectiles (assuming y vertical, x horizontal), shape of satellite dishes and headlights (to focus beams, but that's conceptual). For FE, know that parabolic shapes come from constant acceleration motion etc.
  Trap: In the reference, they might list parabola standard as $y^2 = 4px$ (which is sideways opening). Remember to match the orientation.

- **Hyperbola (center at (h,k)):** $\frac{(x-h)^2}{a^2} - \frac{(y-k)^2}{b^2} = 1$ (opens left-right) or $-\frac{(x-h)^2}{a^2} + \frac{(y-k)^2}{b^2} = 1$ (opens up-down).
  Foci: for hyperbola, $c^2 = a^2 + b^2$. Foci are outside the vertices. If horizontal transverse axis, foci at $(h \pm c, k)$. Eccentricity $e = c/a > 1$.
  Asymptotes: lines through center with slopes $\pm b/a$ for horizontal hyperbola (equations: $y - k = \pm\frac{b}{a}(x - h)$).
  This is often a needed property: as $x \to \infty$, hyperbola tends to these lines.

  Uses: Perhaps in defining loci of constant difference in distances (like hyperbolic navigation), or the shape of an open curve like a cooling tower (they are often hyperbolic). The structural shape of some bridges or towers uses hyperbolas due to their properties.
  Trap: Not confusing sign: hyperbola has a minus between terms in standard form.

Given the FE exam's scope, memorizing foci formulas is probably not necessary, but recognizing the type and maybe knowing circle and parabola specifics is useful.

Explanation & Analysis: In an exam setting, you might be simply asked which type of curve an equation is, or given multiple equations to match with conic names. The discriminant method is quickest if it's a general form. If the equation is already neat (no xy term), you can often tell by looking: - Two squared terms same sign (and coefficients if no scaling different? If different coefficients but same sign, still ellipse) => ellipse/circle.

- One squared term only (other linear) => parabola. - One positive, one negative squared term => hyperbola. - Also check if equals zero and factorable easily: maybe it's just lines.

Example:

Identify $x^2 - 4x + y^2 + 6y + 9 = 0$. Complete squares: $(x^2 - 4x + 4) + (y^2 + 6y + 9) = 4 - 9$ (move constants). Actually, do properly: $(x-2)^2 - 4 + (y+3)^2 - 9 + 9 = 0$, simplifies to $(x-2)^2 + (y+3)^2 = 4$. That's a circle (radius 2, center (2,-3)). You could also discriminant: $A = 1, B = 0, C = 1$ so $B^2 - 4AC = -4 < 0$ and $A = C$, circle confirmed. If time allows, completing square gave more info (center, radius), but classification alone is quick with discriminant.

Why classification matters: If you know the type, you know general behavior: - Ellipse: bounded (x and y limited range), closed curve. - Parabola: unbounded in one direction (e.g., y goes to infinity as x increases, etc.), one branch. - Hyperbola: unbounded in two opposite directions, two separate branches, asymptotic behavior.

If a physical situation yields a conic equation, understanding which one can guide your interpretation. E.g., if you derive an equation of motion and get something like $x^2 - (ct)^2 = constant$, that hints at hyperbolic motion.

Pitfalls in problems:

- If given numeric equation, easy to misclassify if you forget to consider sign conditions. E.g., $x^2 + y^2 - 10x + 8y + 25 = 0$. You might see $x^2 + y^2$ and think circle, but if you complete it: $(x^2 - 10x + 25) + (y^2 + 8y + 16) = -25 \pm 16$ gives $(x-5)^2 + (y+4)^2 = -41$. That's impossible (no real points, because $radius^2$ would be -41). The discriminant here $A = 1, C = 1, B = 0$ gave -4 (ellipse/circle type), but the constant made it degenerate (no solution). So also consider that the equation must have a nonnegative right-hand side after completing square to actually represent points. If it doesn't, answer might be "no real curve" or "degenerate/no solution."

- If they specifically mention "eccentricity" or "focus", they expect you to recall or derive those details for that conic. For a parabola, focus at distance p from vertex etc. For ellipse/hyperbola, focus using $c^2 = a^2 \pm b^2$. It's rare in FE to need that, but just in case, knowing where to find it in the handbook or how to get it quickly can help. (The handbook does list some focus/directrix info in that conic section).

Wrap-up: For analytic geometry in summary, conics are the high-level concept bridging algebra and geometry. In preparation, practice by taking a general equation and classifying it, or by writing the equation given a description: e.g., "an ellipse centered at origin with x-intercepts ±4 and y-intercepts ±2" -> $\frac{x^2}{16} + \frac{y^2}{4} = 1$. Or "a parabola with focus (2,0) and directrix x = -2" -> that's an East-opening parabola centered at (0,0)? Actually, vertex is midway between focus and directrix: focus (2,0), directrix x=-2, so vertex at (0,0), opens right with p=2, eq: $y^2 = 4(2)x$ i.e. $y^2 = 8x$. These kinds of exercises reinforce understanding. However, keep in mind time – on exam day, classification and maybe very basic property extraction is all that's usually needed.

Topic 02 - Calculus

Calculus is the mathematics of **change** (through derivatives) and **accumulation** (through integrals). In the FE Mechanical Exam, calculus concepts appear in many contexts: you might need to find a slope or rate (derivative) for a kinematics or optimization problem, compute an area or accumulated quantity (integral) for a thermal or fluids problem, approximate a function or value using a series expansion, or handle equations with multiple variables. Mastering these tools gives you flexibility on exam day. Typical question archetypes include finding a maximum/minimum of a function (using derivatives to locate critical points), evaluating a definite integral (often representing physical work or area under a curve), or using a Taylor series to linearize a formula or estimate a value. The following subtopics walk through the core calculus principles you need, with an eye toward efficient problem-solving on the FE exam.

K01.T02.S01 – Differential Calculus (Single-Variable Derivative Rules & Applications)

Principle (Derivatives): A derivative represents an *instantaneous rate of change* of a function with respect to one of its variables. In geometric terms, it's the slope of the tangent line to the function's curve at a point. Key ideas include:

- **Definition:** The derivative of $y = f(x)$ at a point is defined by the limit of the difference quotient: $f'^{(x)} = \lim_{\Delta x \to 0} \frac{f(x+\Delta x)-f(x)}{\Delta x}$. This limit, if it exists, gives the slope of the curve $y = f(x)$ at x. It formalizes the idea of a *small change in x leading to a change in y*.
- **Notation:** Common notations for the derivative are $f'^{(x)}$, $\frac{dy}{dx}$, or $D_x\, y$. All indicate the same concept of instantaneous rate of change. For higher derivatives, $f''^{(x)}$ is the second derivative (rate of change of the first derivative), and so on.
- **Derivative Rules:** Instead of computing the limit definition every time, we use rules: linearity (derivative of a sum is sum of derivatives), the power rule (e.g. $\frac{d}{dx} x^n = nx^{n-1}$), the product rule, quotient rule, and chain rule. These rules allow quick differentiation of most algebraic combinations of functions.
- **Applications:** Derivatives help identify **extrema** (maxima/minima) by finding where $f'^{(x)} = 0$ (critical points) and using the second derivative $f''^{(x)}$ to test concavity. They also model physical rates: for example, if $x(t)$ is position, $v(t) = x'^{(t)}$ is velocity and $a(t) = v'^{(t)} = x''^{(t)}$ is acceleration. On the exam, you may be asked to compute a derivative at a point, apply the chain rule in a units conversion, or determine where a function's slope is zero (optimization problems).
- **Limits and Continuity:** A function must be continuous (no jumps) to be differentiable at a point, and differentiability implies local linear behavior. Techniques like L'Hôpital's rule help evaluate indeterminate limits by differentiating numerator and denominator, connecting to the idea of a derivative in disguise for $0/0$ situations [^2].

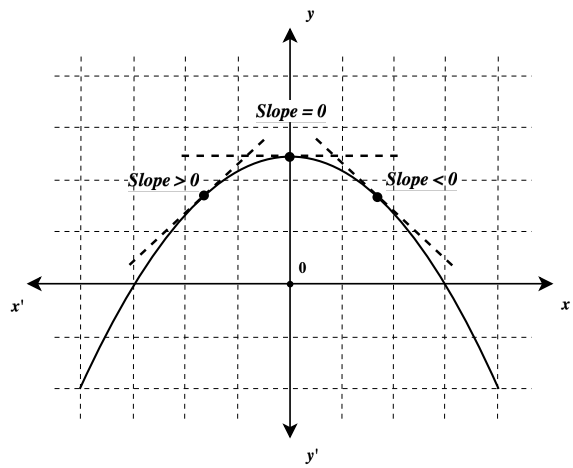

Geometric interpretation of the derivative: A parabola $y = 4 - x^2$ with tangent lines at three points. To the left, the tangent has positive slope > 0 (function increasing); at the top, the slope $= 0$ (horizontal tangent, a local maximum); to the right, the slope < 0 (function decreasing). The derivative $f'^{(x)}$ at each point equals the slope of these tangent lines.

Exam Handbook Search Cues (Not affiliated with or endorsed by NCEES): *derivative, differentiation, slope, chain rule, critical point, L'Hospital* (the exam handbook's calculus section lists general derivative formulas and tests for extrema).

Equation Passport – Derivative (Definition & Concept)
Determines *the instantaneous rate of change of a function, i.e. the slope of the curve.*

- **Formal Definition:** $f'^{(x)} = \lim_{\Delta x \to 0} \frac{f(x+\Delta x)-f(x)}{\Delta x}$.
- **Variables:** x – independent variable (units vary); $y = f(x)$ – dependent variable; Δx – a small increment in x; $\Delta y = f(x + \Delta x) - f(x)$ – corresponding change in y.
- **Units:** The units of $f'^{(x)}$ are "units of y per unit of x" (e.g. if y is in m and x in s, $f'^{(x)}$ is in m/s). Always check that this rate makes sense for the problem's context.
- **Assumptions & Scope:** $f(x)$ must be continuous around the point and the limit must exist (no sharp corners or vertical tangents). Valid for single-variable real functions. For one-sided derivatives, Δx approaches 0 from one side.
- **Limit Check:** If $f(x)$ is linear, $f'^{(x)}$ equals the constant slope (the limit simply yields that slope for all x). If $f(x)$ is differentiable, as $\Delta x \to 0$, the difference quotient should approach a finite value. If Δx is not taken to 0, the

fraction is just an average slope over an interval, not instantaneous.

- **Use vs. Alternatives:** Use the derivative definition for conceptual understanding or deriving rules. In practice, **use standard rules** (power, product, chain, etc.) for efficient calculation instead of the raw limit for each problem. The definition is the foundation, but on the exam you'll usually apply known differentiation formulas.

Common Exam Traps:

(1) **Algebraic mistakes** when applying product/quotient or chain rule (e.g. forgetting to multiply by the inner derivative in chain rule).
(2) **Sign errors**: e.g. derivative of $\cos x$ is $-\sin x$ [^1], missing the negative sign is a common slip.
(3) **Units confusion**: treating the derivative as unitless or mixing units between x and y. Always carry units through differentiation—especially if x is time, your derivative represents a physical rate.
(4) **Critical points vs. inflection**: Remember $f'^{(x)} = 0$ can indicate a max, min, **or neither** (could be a horizontal inflection). Use $f''^{(x)}$ to distinguish maxima (negative second derivative) from minima (positive second derivative).

Footnotes:

Minor nuances include using radian measure in trigonometric derivatives [^1], and remembering that "$D_y x$" or similar unconventional notation might appear (where $D_y x$ would mean differentiate x with respect to y, an unusual scenario – likely not in FE). But standard FE problems stick to y' or $\frac{dy}{dx}$ for single-variable functions.

Variations & Related Forms:

- **First vs. Higher Derivatives:** The first derivative $f'^{(x)}$ gives slope or rate. The second derivative $f''^{(x)}$ gives the curvature or acceleration (rate-of-change of the rate-of-change). In engineering contexts, $f''^{(x)} < 0$ indicates a local maximum (curve concaves down) and $f''^{(x)} > 0$ a local minimum (concaves up). Higher derivatives (third, fourth, etc.) appear less in FE Mechanical, but you might see acceleration $a = d^2x/dt^2$ if interpreting motion.
- **Common Differentiation Formulas:** From the handbook's table (know these by heart): $\frac{d}{dx}(c) = 0$ for constant c; $\frac{d}{dx}(x) = 1$; $\frac{d}{dx}(x^n) = nx^{n-1}$ (power rule); $\frac{d}{dx}(\sin x) = \cos x$ and $\frac{d}{dx}(\cos x) = -\sin x$ [^1]; $\frac{d}{dx}(e^x) = e^x$; etc. The FE exam expects you to apply these quickly. For instance, if $y = 5x^3 - 2\sin x$, then $y' = 15x^2 - 2\cos x$ directly by linearity and basic formulas.
- **Product & Quotient Rules:** For two functions $u(x)$ and $v(x)$: product rule $\frac{d}{dx}[u \cdot v] = u\,v' + v\,u'$; quotient rule $\frac{d}{dx}\left[\frac{u}{v}\right] = \frac{v\,u' - u\,v'}{v^2}$ (provided $v \neq 0$). These extend differentiation to more complex expressions. A common pitfall is to mis-order terms or forget a term; writing out product/quotient rule carefully helps avoid sign mistakes.
- **Chain Rule:** For a composite function $y = f\big(u(x)\big)$, $\frac{dy}{dx} = f'^{(u)} \cdot u'^{(x)}$. In words, differentiate the outer function, then multiply by the derivative of the inner function. This rule is crucial for correctly differentiating, say, $f(x) = \sin(x^2)$ (you get $\cos(x^2) \cdot 2x$), or converting units in rates (e.g. if T is given as a function of time in minutes but you need dT/dt in seconds, chain rule implicitly handles the 60 factor). Forgetting the chain rule is a frequent cause of wrong answers.
- **L'Hôpital's Rule:** This is a special case tool for limits: if $\lim_{x\to a}\frac{f(x)}{g(x)}$ gives an indeterminate form $0/0$ or ∞/∞, then $\lim_{x\to a}\frac{f(x)}{g(x)} = \lim_{x\to a}\frac{f'^{(x)}}{g'^{(x)}}$ *provided* that latter limit exists [^2]. While not a "derivative of a quotient" per se, it leverages derivatives to evaluate limits. In exam practice, you might use L'Hôpital's rule to find a limit related to a rate (e.g. a small angle approximation limit like $\lim_{x\to 0}\frac{\sin x}{x} = 1$, which you could also get via series or known result). Remember it only applies to the indeterminate forms mentioned and requires differentiating numerator and denominator separately.

Special Notes (Calculator Tips):

If you need a numerical value of a derivative at a point, some FE-approved calculators (like the TI-36X Pro or Casio fx-991 series) have a built-in numeric derivative function. For example, you can use the d/dx feature to evaluate $f'^{(a)}$ by inputting the function and the point a. This can double-check a manual derivative result.

Ensure your calculator is in radian mode for trig functions [^1] when using these features – differentiating $\sin x$ or evaluating $\cos(0.5)$ assumes x is in radians in calculus formulas. Also, when hunting through the on-screen *FE Reference Handbook* for formulas, use keywords like *"derivatives"* or *"differential calculus"* to quickly jump to the table of derivative formulas and rules.

Explanation (How to Use Derivatives on the FE Exam): The derivative is used whenever a problem asks "how fast" or "what is the rate" or whenever you need to optimize something. For example, if a question gives a position function $s(t)$ and asks for velocity at time t, you'd differentiate $s(t)$ to get $v(t)$. If asked for the maximum efficiency of a system given as a function of some variable, you'd set the derivative to zero to find the critical point. In optimization problems, **follow these steps**:

- Take the derivative and set it equal to zero to find critical point(s).
- Use the second derivative to test whether each critical point is a max or min (or use logic based on the problem context).
- Don't forget to consider endpoints of the domain if applicable (sometimes the highest or lowest value occurs at the boundaries rather than where the derivative is zero). The exam often provides straightforward functions to differentiate, but the real trick is interpreting the result: e.g. identifying that a negative derivative means a quantity is decreasing, or that a zero derivative coupled with a sign change from + to – indicates a local maximum.

Analysis (Term-by-Term): Let's break down the definition formula and a typical derivative result to ensure understanding. In the definition $f'^{(x)} = \lim_{\Delta x\to 0}\frac{f(x+\Delta x)-f(x)}{\Delta x}$: the numerator $f(x+\Delta x) - f(x)$ is the change in output, and the denominator Δx is the change in input. As Δx shrinks to an "infinitesimal," this ratio

approaches a single value – that's the instantaneous rate of change. For example, if $f(x) = x^2$, then $\frac{(x+\Delta x)^2 - x^2}{\Delta x} = \frac{2x\Delta x + (\Delta x)^2}{\Delta x} = 2x + \Delta x$. Taking the limit as $\Delta x \to 0$ leaves $2x$. Thus $f'^{(x)} = 2x$. This matches the power rule and tells us the slope of $y = x^2$ at any x is $2x$ (so at $x = 3$, slope 6; at $x = 0$, slope 0). Physically, if x^2 were a position (in m) as a function of time x (in s), the velocity at time 3 s would be 6 m/s. Always interpret the derivative's units: it's a quick way to sanity-check. If you ended up with a derivative formula $2x$ for position (m) vs time (s), the units are (m/s) which makes sense for velocity. If you got $2x^2$ erroneously, units would be (m·s), which is nonsensical for velocity – a clear red flag. Each term in a differentiated result corresponds to part of the original function. In $y' = 15x^2 - 2\cos x$ (from $y = 5x^3 - 2\sin x$ as earlier), the $15x^2$ came from the polynomial $5x^3$ (using power rule, bring down 3 and multiply by 5), and the $-2\cos x$ came from $-2\sin x$ (derivative of $\sin x$ is $\cos x$, times -2 constant). If you have a sum, you differentiate each part independently and keep their signs. It's wise to mentally map each term in y' to its origin in y to catch any omissions or sign errors. Finally, when evaluating a derivative at a specific value, plug the number in carefully. If using your calculator's derivative function, input the expression correctly with parentheses and the correct mode (radians for trig).

At-a-Glance Summary (Common Derivative Rules):

Rule	Formula (derivative)	Notes/Pitfalls
Constant	$\frac{d}{dx}(C) = 0$	Any constant term vanishes.
Power	$\frac{d}{dx}(x^n) = n\,x^{n-1}$	n can be any real number (works for fractions, negatives too). Don't forget to reduce exponent by 1.
Sum/Difference	$\frac{d}{dx}[u(x) \pm v(x)] = u' \pm v'$	Linear operator: treat each term separately. Sign errors (especially with "–") are common mistakes.
Product	$\frac{d}{dx}[u \cdot v] = u\,v' + v\,u'$	Differentiate one factor at a time (left then right) and add. Both pieces must be included.
Quotient	$\frac{d}{dx}\left[\frac{u}{v}\right] = \frac{v\,u' - u\,v'}{v^2}$	"Lo d hi minus hi d lo, over lo-lo" is a memory rhyme. Remember the order: $v\,u' - u\,v'$.
Chain	$\frac{d}{dx}f\big(g(x)\big) = f'^{(g(x))} \cdot g'^{(x)}$	Multiply by inner derivative. A common error is to omit this, especially in trig or exp: e.g. $d\big(\sin(5x)\big)/dx = 5\cos(5x)$.

K01.T02.S02 – Integral Calculus (Single-Variable Integration Techniques & Applications)

Principle (Integrals): An integral accumulates quantities over an interval – essentially the "area under a curve" (when the curve is above the axis) or the net area (subtracting the area below the axis). The **definite integral** $\int_a^b f(x)\,dx$ gives a number representing the net accumulation of $f(x)$ from $x = a$ to $x = b$. The **indefinite integral** $\int f(x)\,dx$ represents a *family* of antiderivative functions whose derivative is $f(x)$. Key points:

- **Antiderivatives:** Integration is the inverse operation of differentiation. If $F'^{(x)} = f(x)$, then $\int f(x)\,dx = F(x) + C$. This relationship is the **Fundamental Theorem of Calculus**, which links the two halves of calculus. It means you can find areas by finding an antiderivative.
- **Definite vs. Indefinite:** A definite integral $\int_a^b f(x)\,dx$ is a number (with units equal to the product of units of y and x). It can be computed as $F(b) - F(a)$ where F is any antiderivative of f. An indefinite integral $\int f(x)\,dx = F(x) + C$ is a general expression. On the FE, definite integrals often appear in engineering contexts (e.g. computing work $W = \int_{x_1}^{x_2} F(x)\,dx$), whereas indefinite integrals might appear as part of solving differential equations or just testing your basic integration skills.
- **Basic Techniques:** Many integrals can be evaluated by recognizing the reverse of derivative rules. For instance, the power rule in reverse: $\int x^n dx = \frac{x^{n+1}}{n+1} + C$ (for $n \neq -1$). Some integrals require techniques like **substitution** (the reverse of chain rule), **integration by parts** (the reverse of product rule), or **partial fraction decomposition** (for rational functions). Recognizing which technique to apply is crucial: a product of a polynomial and exponential might call for integration by parts; an integral of $\frac{3x}{x^2+1}dx$ suggests substitution $u = x^2 + 1$; a rational function like $\frac{dx}{x^2-1}$ may need partial fractions.
- **Applications:** Geometrically, integrals compute areas and volumes (using methods like area under curve, solids of revolution, etc.). Physically, integrals compute accumulated quantities: e.g. displacement from velocity over time $s = \int v(t)dt$, work from force over distance $W = \int F(x)dx$, or heat transfer over a temperature gradient. On the FE exam, you might integrate a simple function to find an area or to combine a rate into a total quantity. In many cases, the problem is set up such that the integral is straightforward or the answer can be left in integral form if it's a conceptual question.

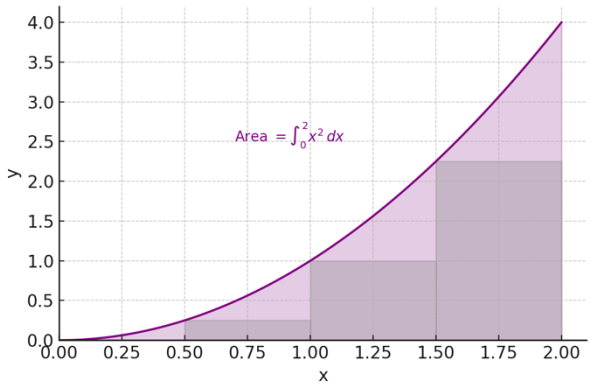

Definite integral as area under a curve: The graph shows $y = x^2$ from $x = 0$ to $x = 2$. The shaded region represents $\int_0^2 x^2\ dx$, the area under $y = x^2$ between 0 and 2. A few sample rectangles are drawn to illustrate a Riemann sum approximation of this area. As the rectangles get thinner (more of them), their total area approaches the true integral. In this case, the exact area is $\frac{8}{3}$ (in appropriate units). Integrals accumulate the value of $f(x)$ (height) times an infinitesimal width dx, summing up to the total area.

Exam Handbook Search Cues (Not affiliated with or endorsed by NCEES): *integral, integration, ∫, antiderivative, integration by parts, partial fractions, definite integral, area under curve.* (The handbook's *Mathematics* section lists common integrals and methods by name; searching "Integrals" or "Integration" will jump to tables of integrals and a brief mention of methods A, B, C corresponding to parts, substitution, partial fractions.)

Equation Passport – Integration by Parts:

Allows integration of a product of functions by transferring differentiation from one factor to the other.

- **Formula:**
  $\int u\ dv = u\,v - \int v\ du$.
  This is the integration-by-parts formula (analogous to the product rule in reverse).
- **Variables:** $u(x)$ – a function you choose to differentiate (it becomes du); $dv(x)$ – the remaining part of the integrand, which you will integrate to get v. $du = u'^{(x)}dx$ and $v = \int dv$.
- **When to Use:** Apply when the integrand is a product $u \cdot w$ and one part becomes simpler when differentiated (choose that as u), while the other is easily integrable (choose that as dv). Classic examples: xe^x (let $u = x$, which simplifies to $du = 1\,dx$, and $dv = e^x dx$ giving $v = e^x$); or $x\cos x$ (let $u = x$, $dv = \cos x dx$). It's also useful for integrating logarithmic or inverse trig functions, by choosing u as the log/inverse trig (since we can't integrate those directly, but we know their derivatives).
- **Assumptions & Scope:** Functions $u(x)$ and $v(x)$ must be differentiable/integrable over the interval. Integration by parts works for definite integrals too: $\int_a^b u\ dv = [u\,v]_a^b - \int_a^b v\ du$. Don't forget to evaluate the boundary term $[uv]_a^b = u(b)v(b) - u(a)v(a)$ if doing a definite integral.
- **Limit Checks:** If one of the functions is such that its derivative du is 0 (for example, if u becomes a constant), the formula reduces neatly: $\int u\ dv = u\,v - \int 0\ dx = u\,v$. This is a sanity check—if you cleverly choose u such that $du = 0$ (which means u was constant), integration by parts gives the trivial result $u \cdot v$. Another check: if you apply parts to an integrand that is already a simple derivative, it should return the original product rule identity.
- **Sibling Methods:** Choose integration by parts rather than substitution when the integrand doesn't contain a clear inner function with its derivative, but instead appears as a product of two different function types (e.g., a polynomial times a log, trigonometric, or exponential function). *Do not use parts* if a simple substitution $u =$ (something) would do, substitution is usually simpler. Also, if the integrand is a basic form from the formula tables (like $\sin x$ or e^x), no need for parts or substitution; just recall the antiderivative.
- **Common Exam Traps:** (1) **Forgetting the "$-\int v\ du$" part:** Students sometimes erroneously write $\int u\ dv = u\,v + \int v\ du$ (with a + instead of -) – remember it's minus! The product rule $d(uv) = u\,dv + v\,du$ rearranged gives $\int u\ dv = uv - \int v\ du$. (2) **Choosing u and dv poorly:** If your resulting ∫v du is *harder* than the original ∫u dv, you may have picked the parts wrong. A rule of thumb is *LIATE* (Log, Inverse trig, Algebraic, Trig, Exponential) – choose u from the first category that appears in the integrand (logs first, etc.), as those typically simplify when differentiated. (3) **Dropping the constant of integration:** When finding an indefinite integral, always append "+ C" [^3]. On a definite integral, evaluate the boundaries – forgetting to subtract $F(a)$ from $F(b)$ is a common slip.

Table Passport – Integration Techniques Overview

Knowing how to approach an integral is half the battle. Use this guide to decide your strategy:

Technique	Clues to Apply	How It Works	Don't Do This
Substitution (u-sub)	Integrand looks like $f\big(g(x)\big) \cdot g'^{(x)}$ or a composition. A part of the integrand's derivative is present elsewhere in the integrand. Example clue: $\int (3x^2)\cos(x^3)dx$ – notice $3x^2$ is derivative of x^3.	Set $u = g(x)$, then $du = g'^{(x)}dx$. The integral becomes $\int f(u)\ du$, which is simpler. After integrating in u, substitute back $u = g(x)$.	After substituting, **don't forget to convert all** x terms to u. Also, do not reuse the same variable; when you set $u = \cdots$, change the differential to du.
Integration by Parts	Integrand is a product $u \cdot v$ of two different types of functions (poly * log, poly * exp, trig * poly, etc.), especially when one factor simplifies upon differentiation or the other is easy to integrate. Also, definite integrals where the integrand is a product.	Choose u (to differentiate) and dv (to integrate). Compute du and v. Plug into $\int u\ dv = uv - \int v\ du$. If definite, apply limits to uv term and to the remaining integral. You may sometimes need to apply parts twice if the first pass doesn't fully resolve it.	Don't pick dv as something you *can't* integrate, or u that becomes more complex when differentiated. Also, don't forget the subtraction in the formula. If the resulting $\int$ is *the same as the original*, consider solving for it algebraically (this happens in loops).
Partial Fractions	The integrand is a rational function $\frac{P(x)}{Q(x)}$ (polynomial over polynomial). You see an algebraic fraction that could be decomposed (especially if $\deg P < \deg Q$ or you can do long division to achieve that).	Factor the denominator $Q(x)$ into linear/quadratic factors. Write $\frac{P(x)}{Q(x)}$ as a sum of simpler fractions (with constants or linear terms as numerators). Determine constants by solving equations (cover-up method or equating coefficients). Then integrate each simple fraction (many will be log forms or arctan forms).	Don't apply if the integrand isn't a rational function. Ensure the numerator degree is less than denominator's (do polynomial division first if not). A common mistake is algebra errors in solving for coefficients – double-check by recombining your partial fractions to see if you get the original integrand. Also, **do not** integrate before splitting – the whole point is to split first!
Trigonometric Integrals (special subcase)	Integrand involves products or powers of trig functions, like $\sin^m x \cos^n x$.	Use trig identities to simplify. For example, if one power is odd: save one sine/cosine and convert the rest using $\sin^2 x = 1 - \cos^2 x$ or $\cos^2 x = 1 - \sin^2 x$, then use substitution. If powers are even, use half-angle identities ($\sin^2 x = (1 - \cos 2x)/2$, etc.).	Don't try to integrate $\sin^n x$ or $\cos^n x$ directly by power rule (doesn't work). Identify an approach from symmetry or known identities.

Special Notes (Calculator Tips):

The FE exam calculators can **numerically evaluate definite integrals**. For instance, the TI-36X Pro and Casio fx-115/991 have an $\int_a^b ()\ dx$ function where you input the integrand and the bounds. This can be a lifesaver to check your work on a definite integral problem. Be careful: you must input the integrand correctly and set the calculator in radian mode if the integral involves trig (e.g. $\int_0^{\pi/2} \cos x\ dx$ will output 1 in radian mode, but in degree mode it would integrate over 0 to 90 degrees incorrectly). Calculators **cannot do symbolic integration**, so you can't get an antiderivative expression out of them – you'll only get a numeric result for definite integrals. For **indefinite integrals**, you'll rely on remembering forms or using the handbook's table of integrals. Use the **Exam Handbook's integrals table** for quick reference: for example, if you forget $\int \ln x\ dx$, looking up "logarithm" in the handbook would show the formula $x\ln x - x + C$. Also remember to include the integration constant "+C" [^3] in symbolic answers (the exam might have a multiple-choice option that reflects missing the +C as a trap in some contexts).

Explanation (Using Integrals on the FE Exam):

To solve an integration problem, first identify what type it is. Is it a straightforward antiderivative you can recall? (e.g. $\int \frac{1}{x} dx = \ln|x|$.) Is it asking for an area or physical quantity? Translate the words into an integral expression if needed. For a definite integral, set up the integral with correct limits and integrand. Sometimes on the FE, setting up the integral correctly is the main task, and you might not have to fully compute it if answer choices are given in integral form. If you do compute it, apply the appropriate technique: substitution is usually the fastest if applicable. For example, if you see $\int 2x\sqrt{x^2+1}\ dx$, recognize $u = x^2 + 1$ (then $du = 2x\ dx$) which turns it into $\int \sqrt{u}\ du$. Integration by parts is a bit slower but necessary for things like $\int xe^x dx$. A tip: when using integration by parts, clearly label your choices for u and dv on paper to avoid confusion. If the integral is definite and you apply a substitution, don't forget to also change the limits to the new u values (or convert back to x after finding the antiderivative before evaluating). Always double-check the result by differentiating it (quick mental or written check): differentiating your antiderivative should return the original integrand (including any constant producing 0). If it

doesn't, you know something is off. Also be mindful of **units**: if the problem is physical (say computing work $\int F\ dx$), carry the units through your integration to ensure the result's units make sense (force N times distance m yields energy J, etc.). This can help catch errors like forgetting a conversion factor. Lastly, many integration problems on the exam are set up with nice cancellations or simplifications if you prepare them well. For instance, symmetry can simplify an integral: $\int_{-a}^{a} f(x)dx = 0$ if f is odd, or $2\int_0^a f(x)dx$ if f is even. Keep an eye out for these time-saving observations on multiple-choice questions.

Analysis (Term-by-Term & Pitfalls):

Consider the definite integral $I = \int_0^2 x^2\ dx$ from the figure. Using antiderivatives, $F(x) = \frac{x^3}{3}$ is an antiderivative of x^2. So $I = F(2) - F(0) = \frac{8}{3} - 0 = \frac{8}{3}$. Breaking this down: the term $x^3/3$ came from increasing the power of x^2 by one (to x^3) and dividing by the new exponent 3. This is the reverse of the power rule for differentiation. We include no "+C" for definite integrals because the constant cancels out in the subtraction. If we had integrated x^2 indefinitely, we'd write $\frac{x^3}{3} + C$; the +C indicates there are infinitely many antiderivatives vertically shifted. For a definite integral, conceptually those constants subtract out: $[F(x) + C]_0^2 = F(2) + C - (F(0) + C) = F(2) - F(0)$. Another example: $\int \cos x\ dx = \sin x + C$. We know this because we differentiate $\sin x$ to get $\cos x$. Always mentally differentiate your result: if you got $\sin x$ as the antiderivative of $\cos x$, differentiating $\sin x$ indeed returns $\cos x$ – good. If you accidentally thought $\int \cos x dx = -\sin x$, differentiating $-\sin x$ gives $-\cos x$ which is off by a sign, flagging the mistake. For integration by parts, say we evaluate $\int xe^x dx$. We set $u = x$ (so $du = dx$) and $dv = e^x dx$ (so $v = e^x$). The formula gives $xe^x - \int e^x(1)\,dx = xe^x - e^x + C = e^x(x-1) + C$. If we differentiate $e^x(x-1)$, we get $e^x(x-1) + e^x(1) = xe^x$, confirming it's correct. Each term in the integration by parts result has a clear origin: xe^x was $u \cdot v$, and $-e^x$ was $-\int v\ du$. It's easy to lose track of minus signs or constants in long integrals, so write out intermediate steps.

Common pitfalls to watch for: forgetting dx in integrals (always include it, it's part of the notation indicating the variable of integration), integrating the derivative instead of the original function (occasionally a question might give you $f'^{(x)}$ and ask for $f(x)$ at some point – you'd integrate $f'^{(x)}$ to recover $f(x)$, but ensure you handle constants via initial conditions if provided).

When dealing with absolute values inside integrals (like $\int |\sin x| dx$), remember you must split the integral where the inside changes sign. However, that level of complexity is rare in FE contexts unless they guide you. Finally, keep track of boundaries when doing definite integrals with substitution: if you change to u variables, updating the limits avoids having to back-substitute x at the end (less chance of error). For example, $\int_0^{\pi/2} \sin^2 x\, dx$ using $u = \cos x$ means $du = -\sin x dx$, that's tricky; better use identity or adjust method. Many FE problems that involve integration are standard and might even allow skipping steps if you recognize a known result (like area of a triangle, area of a quarter circle, etc.). But if you set up an integral, solving it systematically with the above techniques will get you to the correct answer.

At-a-Glance Summary (Common Integrals & Forms):

Integral Form	Antiderivative (General Result)	Notes (FE usage)
$\int x^n dx$	$\frac{x^{n+1}}{n+1} + C$	Power rule in reverse (valid for $n \neq -1$). Make sure to add +C for indefinite.
$\int \frac{1}{x} dx$	$\ln\lvert x\rvert + C$	Natural log arises; absolute value because of log domain (the exam usually presumes $x > 0$ context unless stated).
$\int e^x dx$	$e^x + C$	The exponential is its own derivative/antiderivative. Similarly, $\int a^x dx = \frac{a^x}{\ln a} + C$.
$\int \sin x\ dx$	$-\cos x + C$	Trig integrals: be mindful of sign (derivative of cos is -sin, so ∫sin gives -cos). $\int \cos x dx = \sin x + C$. [^1]
$\int \sec^2 x\, dx$	$\tan x + C$	Recall derivative of $\tan x$ is $\sec^2 x$, hence this result. Useful in integrals involving trig identities or when you spot $\sec^2$.
$\int \frac{1}{1+x^2} dx$	$\arctan x + C$	Inverse trig results: know that $\frac{d}{dx}(\arctan x) = \frac{1}{1+x^2}$. Similarly, $\int \frac{1}{\sqrt{1-x^2}} dx = \arcsin x + C$.
$\int u'^{e^u} dx$ or $\int u' \sin(u) dx$ etc.	$e^u + C$ or $-\cos(u) + C$ etc.	Patterns for substitution: if you see a function inside and its derivative outside, integration collapses directly. E.g. $\int 2x\cos(x^2)dx = \sin(x^2) + C$. Recognize these to save time.
Integration by Parts	$\int u\ dv = u\,v - \int v\ du$	Use for product of unlike functions. One common FE scenario: integrating te^{-t} in a transient heat or dynamics problem – apply parts.
Partial Fraction example	$\int \frac{dx}{x^2 - 1}$	Break into $\frac{1}{2}\ln\left\lvert\frac{x-1}{x+1}\right\rvert + C$.

K01.T02.S03 – Series and Expansions (Taylor Series)

Principle (Series Expansions): A series is a sum of terms, often infinitely many, that can represent functions or sums succinctly. In calculus, **power series** (infinite polynomials) are used to expand functions like e^x, $\sin x$, etc., around a point. The most prominent is the **Taylor series**, which expresses a smooth function as an infinite sum of its derivatives at a single point. Understanding series helps in approximation: for instance, using only the first few terms of a Taylor series to estimate a function's value. Key points:

- **Taylor Series Definition:** If $f(x)$ is infinitely differentiable around $x = a$, the Taylor series of f about a is $f(x) = f(a) + f'^{(a)(x-a)} + \frac{f''(a)}{2!}(x-a)^2 + \frac{f^{(3)}(a)}{3!}(x-a)^3 + \cdots$, extending indefinitely. This is basically a polynomial with infinitely many terms. When $a = 0$, it's called the **Maclaurin series**. Each term uses the nth derivative $f^{(n)}(a)$ and is divided by $n!$.
- **Convergence:** Not every series converges to the original function for all x. Each power series has a **radius of convergence** R. For $|x-a| < R$, the series converges to $f(x)$ (if it's the function's series). Many common functions (exponential, sine, cosine, etc.) have infinite radius of convergence (their series work for all x). Others, like $\ln(1+x)$, have a finite radius (the series for $\ln(1+x)$ converges for $-1 < x \leq 1$). On the FE, you typically won't be asked to derive convergence radii from scratch, but you should know that using a series outside its convergence range gives wrong results.

Common Series to Know: The FE Exam may expect you to recognize the series for key functions:

- Geometric series: $\frac{1}{1-x} = 1 + x + x^2 + x^3 + \cdots$ for |x|<1.
- Exponential: $e^x = 1 + x + \frac{x^2}{2!} + \frac{x^3}{3!} + \cdots$ (valid ∀x).
- Sine: $\sin x = x - \frac{x^3}{3!} + \frac{x^5}{5!} - \frac{x^7}{7!} + \cdots$ (∀x).
- Cosine: $\cos x = 1 - \frac{x^2}{2!} + \frac{x^4}{4!} - \frac{x^6}{6!} + \cdots$ (∀x).

These expansions are given in the handbook (under "Taylor's Series" and also in some math references) and are good to memorize for quick approximations. For instance, knowing $\sin x \approx x - x^3/6$ for small x can be useful in a pinch for estimation.

Use Cases on Exam: Series might be used in **numerical methods** (e.g. using a Taylor series to approximate a value or to understand error), or in **convergence questions** (like does a series diverge or converge). Mechanical FE might use series in contexts like Fourier series in vibrations or to linearize an equation for small perturbations (taking just first-order terms). A classic simple use: approximate $\sqrt{1.05}$ by series or find the first few terms of expansion of something like $\frac{1}{1-0.2}$. Generally, series provide insight into behavior: e.g. that e^x grows without bound because all positive terms, or that $\sin x \approx x$ for small x (useful for small-angle assumptions in mechanics).

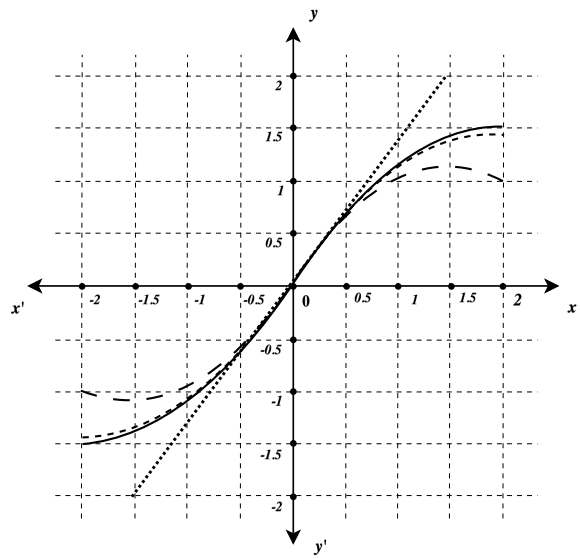

Taylor series approximation example: The graph shows $y = \sin x$ (solid curve) and three polynomial approximations about 0: first-order $y = x$ (dotted line), third-order $y = x - x^3/6$ (long-dashed curve), and fifth-order $y = x - x^3/6 + x^5/120$ (dashed curve). Near $x = 0$, all approximations coincide closely with $\sin x$. The more terms we include, the wider the range over which the polynomial stays close to the true sine curve. However, for larger |x| (beyond about 1 radian here), the lower-order approximations deviate significantly. This illustrates how Taylor series can approximate a function locally and improve with additional terms.

Exam Handbook Search Cues (Not affiliated with or endorsed by NCEES): *Taylor series, Maclaurin, power series, expansion, series convergence, arithmetic series, geometric series*. (The handbook contains a "Taylor's Series" formula and also formulas for arithmetic and geometric progressions under *Mathematics*. Searching "series" will find those sections. It also lists power series properties like term-by-term differentiation/integration.)

Definition/Note Passport – Taylor Series Expansion: *A formula to expand a function into an infinite polynomial, useful for approximations.*

- **Plain-language definition:** The Taylor series of $f(x)$ about $x = a$ is an infinite sum of terms that uses the function's derivatives at a to predict $f(x)$. It's like doing a polynomial fit of infinitely high degree at the point a, perfectly matching the function's value, slope, curvature, etc. at that point.
- **Formal form:** $f(x) = f(a) + f'^{(a)(x-a)} + \frac{f''(a)}{2!}(x-a)^2 + \frac{f^{(3)}(a)}{3!}(x-a)^3 + \cdots$. This formula is given in the exam reference (without the remainder term). If the series converges, taking enough terms will get as close as desired to the true value of $f(x)$.
- **Where it matters (exam impact):** Taylor series show up in approximating functions for small perturbations. For example, in mechanical vibrations, one might linearize $\sin\theta \approx \theta$ when θ is small (using the first term of sin's Maclaurin series). In thermodynamics or fluids, you might see series used for expansion of an exponential (like a truncated series for e^x). Also, numerical method questions might involve the Taylor series to derive

methods or error terms (e.g. the error term in a truncated series is related to the next derivative).

- **Pitfall or confusion point:** A common misunderstanding is using a truncated series outside its valid range. For instance, using $\sin x \approx x$ for $x = 1.5$ radians gives 1.5 vs the true $\sin(1.5) \approx 0.997$; that's a big error. The approximation x only works well when x is near 0 (say within 0.1 rad ~ 5.7° for high accuracy, or within 0.5 rad for a rough estimate). The series truncation error is given by next term in series (with some form of remainder theorem). You won't need the exact remainder formula on FE, but qualitatively: dropping more terms can introduce error, and the further x is from a, the worse a truncated series performs. Another minor confusion: Maclaurin vs Taylor – Maclaurin is just a special case (a Taylor around 0).
- **Micro-check:** True or False? *The third-order Maclaurin polynomial for* $\cos x$ *is* $1 - \frac{x^2}{2} + \frac{x^4}{24}$. – **False.** The third-order means up to x^3 term, but cos x has only even powers. The polynomial given is actually fourth-order (up to x^4). The third-order Maclaurin *approximation* (up to x^3 term) for cos would be $1 - \frac{x^2}{2}$ (stopping at x^2 because the x^3 term is zero). Remember: if a series term is zero (like the x^1 and x^3 terms for cos), the "order" might skip power degrees.

Variations & Related Concepts:

- **Maclaurin Series:** Simply the Taylor series about $a = 0$. For example, e^x Maclaurin series is $1 + x + x^2/2! + x^3/3! + \cdots$. It's useful to just memorize Maclaurin series for the common functions mentioned earlier. If a problem asks for a series expansion and doesn't specify a point, it's usually Maclaurin (around 0).
- **Arithmetic & Geometric Series:** These are simpler, finite-sum or infinite-sum series not involving powers of variables but constant increments or ratios. The **arithmetic progression** formula: for a sequence with difference d, n terms, first term a, last term l, the sum is $S = \frac{n}{2}(a + l)$. The **geometric series** formula for infinite sum (if $|r| < 1$) is $S = \frac{a}{1-r}$. On the exam, you might need to sum a series of numbers (like cash flows in economics or a physics sum). Recognizing a geometric series sum can save time (e.g. summing factors in a finite difference formula). In the handbook under *Progression and Series*, these formulas are provided. They are straightforward but easy to recall: geometric is used when each term is a constant ratio from the previous.
- **Series Properties:** The handbook lists properties such as term-by-term differentiation and integration of power series within the radius of convergence. Meaning, if $f(x) = \sum_{n=0}^{\infty} c_n (x-a)^n$ for |x-a|<R, then $f'^{(x)} = \sum_{n=1}^{\infty} n\, c_n (x-a)^{n-1}$ similarly holds in that interval. This is usually too advanced for direct questioning on FE, but it underpins numerical methods like deriving formulas for derivatives (by truncating series).
- **Truncation Error:** If you truncate a Taylor series after n terms, the error is roughly on the order of the next term. For example, using $1 + x + x^2/2$ to approximate e^x, the next term would be $x^3/6$, so error ~$x^3/6$ for small x (more precisely $e^{\xi} x^3/6$ for some ξ between 0 and x by Taylor's theorem). While you won't derive this on the exam, you might be asked conceptually: "if you use two terms of a series, what's the order of the error?" The answer corresponds to the first omitted term's order.
- **Fourier Series:** (Though more in electrical/computer FE, but mechanical might touch vibrations) – It's a way to express periodic functions as sums of sines and cosines. Not explicitly in our outline, but just be aware it's another kind of series (not power series, but trigonometric series). If needed, the exam might present a Fourier series and you just need to interpret a coefficient or fundamental frequency, but deep knowledge isn't expected in FE Mechanical.

Special Notes (Calculator/Practical): Calculators won't directly give you a series expansion (that's more a CAS capability), but you *can* use them to compute partial sums. For instance, if asked to approximate $e^{0.5}$ using 3 terms of the series, you'd compute $1 + 0.5 + 0.5^2/2 = 1 + 0.5 + 0.125 = 1.625$. You could quickly do that on a calculator, but it's simple enough by hand too. The main caution is *don't sum too many terms manually* if not needed; these series converge, so often just a few terms give a decent approximation. The exam likely won't require summing more than 3–4 terms manually. Another note: the calculator's factorial key (x!) is handy for series coefficients. If you had to compute $\frac{0.5^5}{5!}$, you could compute 5! = 120 easily with that button, and then do 0.5^5 / 120. This avoids arithmetic mistakes in factorials. Also, the combination of series with other math – for example, summing a geometric series for a present worth calculation in economics – might appear, so remember to identify series patterns even outside the "calculus" context.

Explanation (Approximating & Understanding Behavior):

Suppose the exam asks: "Using the Maclaurin series, approximate $\cos(0.2)$ using terms up to x^4." You'd recall or derive: $\cos x \approx 1 - x^2/2 + x^4/24$ for small x. Plugging $x = 0.2$ (in radians): $1 - 0.04/2 + 0.0016/24 = 1 - 0.02 + 0.0000667 \approx 0.9801$. The true cos(0.2) is about 0.98007, so that's very close – the series did great with just three terms. This illustrates how *for small angles, cos ~ 1 - x^2/2*, which often is used in simplifying equations (e.g. small-angle assumption in beam bending: $\cos\theta$ 1 if θ small).

Another example: If asked for the sum of a particular series, like $\sum_{k=1}^{5} k^2$, you could use the known formula $\frac{n(n+1)(2n+1)}{6}$ for sum of squares (if you recall it), or derive by difference of cubic formulas – but that's heavy. More likely, they'd test simpler series: arithmetic or geometric sums as mentioned. For infinite series convergence, a conceptual question might be: "Does $\sum_{n=1}^{\infty} \frac{n!}{n^n}$ converge or diverge?" You might not see that specific, but it tests recognizing that n^n grows way faster than $n!$, so terms go to 0 super fast, implying convergence. Conversely, $\sum \frac{1}{n}$ diverges (harmonic series). A practical use: evaluating a limit via series – e.g. $\lim_{x\to 0} \frac{1-\cos x}{x^2}$. Using series: cos x ~ 1 - x^2/2 + ..., so 1 - cos x ~ x^2/2. Divide by x^2, limit→1/2. (That's quicker than L'Hôpital's rule or trig identity, if you remember the series.) This shows how series can simplify limit computations. In numerical methods, the Taylor series is foundational for deriving formulas like Euler's method error term, Simpson's rule error, etc., but for FE, you just need to conceptually understand a truncated series leaves off a remainder of next term order. If confronted with a series representation on the exam, don't be intimidated by the summation notation. Try writing out the first few terms to see the pattern. For instance, if given $\sum_{n=0}^{\infty} \frac{(-3)^n}{n!}$, writing out: $1 - 3 + \frac{9}{2!} - \frac{27}{3!} + \cdots$ might reveal it's e^{-3} (since that's the Maclaurin series for e^x with x = -3). Indeed,

recognition can turn a series question into a straightforward computation.

Analysis (Term-by-Term in a Series):

Take $e^x = 1 + x + \frac{x^2}{2!} + \frac{x^3}{3!} + \cdots$.

Each term $\frac{x^n}{n!}$ comes from the nth derivative of e^x at 0, which is just 1 (since all derivatives of e^x are e^x and at 0 that's 1). So the coefficient for $(x-0)^n/n!$ is $f^{(n)}(0)/n! = 1/n!$. Summing all these yields e^x exactly for all x. The factorial in the denominator grows very fast, which is why the series converges for any x (the ratio test confirms it). If we truncate after, say, $x^3/3!$, the next term is $x^4/4!$. For a moderate x like x=1, that next term is $1/24 \approx 0.0417$, so truncating there gives about 95.8% of the value (since e^1 ~2.718, partial sum gave ~2.677). The more terms, the closer. Now consider an alternating series like $\sin x = x - x^3/6 + x^5/120 - \cdots$. The terms alternate signs and decrease in magnitude (for all finite x, eventually $x^n/n!$ gets small as n grows, although up-and-down if x large).

An **alternating series** has the property that truncating it yields an error less than the first omitted term (in absolute value) if the terms decrease in size. This is helpful: if you approximate sin x by $x - x^3/6$, the next term is $x^5/120$. If x=0.5, that next term is $0.5^5/120 = 0.00052$, so your error is ~0.00052 or less – very good. If x=2, next term is $32/120 \approx 0.267$, error up to ~0.267, so clearly the series with two terms isn't great at x=2. These quantitative insights aside, the main actionable analysis is: identify what kind of series you're dealing with and recall the relevant formula or property.

In an arithmetic series, consecutive terms differ by a fixed constant; in a geometric series, consecutive terms are related by a fixed constant ratio (each term is the previous term multiplied by that ratio). If confronted with $\sum_{k=0}^{n} a\, r^k$, you should recognize the finite geometric sum formula $a\frac{1-r^{n+1}}{1-r}$. If $n \to \infty$ and |r|<1, it simplifies to $a/(1-r)$. Double-check by plugging simple cases: if a=1, r=0.5, the sum to infinity should be 2 (since 1 + 0.5 + 0.25 + ... →2). Using formula $1/(1-0.5) = 2$, it matches. Check units or context as well: summing something like distances or payments – ensure you apply the correct series formula and not mix up arithmetic vs geometric. A quick note on the *indexing* of series: sometimes it starts at n=1 or n=0; adjust the formula accordingly. E.g. $\sum_{n=1}^{\infty} x^n$ would sum to $\frac{x}{1-x}$ (since it's missing the n=0 term which would have been 1). Such details can trip you if you plug blindly, so align the formula with how the series is indexed. As a final sanity check, any series expansion result you give – if it's a polynomial approximation – should make sense at the expansion point and perhaps a bit around it. If you claim $\ln(1+x) \approx x + x^2/2$ (which is actually wrong, correct is $x - x^2/2 + \cdots$), plugging a small x can validate: say x=0.1, left side ln1.1 ~0.0953. Right side with guess x+x^2/2 = 0.1+0.005=0.105, that's an overshoot (the correct series with minus would give 0.1-0.005=0.095, much closer). So sign matters in series terms – just as much as value – and a quick test can reveal a sign error.

At-a-Glance Summary (Common Series Expansions):

Function or Series	Expansion (Maclaurin series unless noted)	Comments
$\frac{1}{1-x}$ (Geometric)	$1 + x + x^2 + x^3 + \cdots$ for $\lvert x\rvert < 1$. Also, $\frac{1}{1+x} = 1 - x + x^2 - x^3 + \cdots$ for $\lvert x\rvert < 1$.	The simplest power series. Note alternating signs for 1/(1+x). Useful for series testing and quick sums.
e^x	$1 + x + \frac{x^2}{2!} + \frac{x^3}{3!} + \frac{x^4}{4!} + \cdots$ (converges ∀x)	All positive terms. At x=1, sum gives e≈2.718. The factorial growth ensures fast convergence.
$\sin x$	$x - \frac{x^3}{3!} + \frac{x^5}{5!} - \frac{x^7}{7!} + \cdots$ (∀x)	Odd powers only, alternating. Good for small-angle: sin x ≈ x (for x in radians). Next term $-x^3/6$ gives a measure of error.
$\cos x$	$1 - \frac{x^2}{2!} + \frac{x^4}{4!} - \frac{x^6}{6!} + \cdots$ (∀x)	Even powers only, alternating. For very small x, cos x ≈ 1 - x^2/2. This often appears in derivations of small oscillations.
$\ln(1+x)$	$x - \frac{x^2}{2} + \frac{x^3}{3} - \frac{x^4}{4} + \cdots$ for -1 < x ≤ 1	Alternating for positive x. At x=1: series = 1 - 1/2 + 1/3 - 1/4 + ... (converges to ln2). Diverges if x<-1 or x>1.
$(1+x)^n$ (Binomial series)	$1 + nx + \frac{n(n-1)}{2!}x^2 + \frac{n(n-1)(n-2)}{3!}x^3 + \cdots$	If n is a positive integer, this terminates (binomial expansion). If n is not integer, it's an infinite series valid for
$\arctan x$	$x - \frac{x^3}{3} + \frac{x^5}{5} - \frac{x^7}{7} + \cdots$ for	x

K01.T02.S04 – Multivariable Calculus Basics (Partial Derivatives, Gradients, Multiple Integrals, Core Concepts)

Principle (Multivariable Calculus): Many engineering problems involve functions of more than one variable, e.g. $T(x,y)$ temperature varying in a 2D plate, or $P(x,y,z)$ pressure in 3D space, or a cost function $C(x,y)$ depending on two design parameters. **Multivariable calculus** extends derivative and integral concepts to such functions. Core ideas include **partial derivatives** (the rate of change in one direction while holding others constant), **gradients** (vector of partial derivatives indicating direction of steepest increase), **multiple integrals** (double or triple integrals for areas/volumes), and basic **vector calculus** concepts like divergence and curl (which measure how a vector field spreads or rotates).

For FE Mechanical, focus on the basics:

- **Partial Derivative:** For $z = f(x, y)$, the partial derivative with respect to x, denoted $\frac{\partial z}{\partial x}$, is found by differentiating $f(x, y)$ treating y as a constant. It answers: "if I change x a little, how does z change, assuming y is fixed?". Similarly, $\frac{\partial z}{\partial y}$ treats x constant. In notation, we use the curly ∂ to emphasize it's partial [^4]. If $f(x, y) = x^2y + 5y$, then $f_x = \frac{\partial}{\partial x}(x^2y + 5y) = 2xy$ (since y is constant, derivative of x^2y is $2xy$, and $5y$ is constant in x so its derivative is 0). And $f_y = x^2 + 5$ (treat x^2 as constant multiple, derivative of x^2y w.rt y is x^2, derivative of $5y$ is 5).

- **Gradient:** The *gradient* of a scalar function $f(x, y, z)$ is the vector $\nabla f = \left(\frac{\partial f}{\partial x}, \frac{\partial f}{\partial y}, \frac{\partial f}{\partial z}\right)$. In 2D, $\nabla f = (f_x, f_y)$.

  Principle (Multivariable Calculus – continued): The gradient is essentially the multi-variable generalization of a derivative: it points in the direction where the function increases most rapidly, and its magnitude is the steepest slope. For example, if $T(x, y)$ is temperature on a plate, ∇T at a point points toward warmer areas (highest increase of T), and $\| \nabla T \|$ tells how fast temperature rises in that direction.

- **Divergence:** For a vector field $\mathbf{V}(x, y, z) = \langle V_x, V_y, V_z \rangle$, the **divergence** is $\nabla \cdot \mathbf{V} = \frac{\partial V_x}{\partial x} + \frac{\partial V_y}{\partial y} + \frac{\partial V_z}{\partial z}$. It's a scalar that measures "net outflow" at a point. In physical terms, if $\mathbf{V}$ is a velocity field of a fluid, $\nabla \cdot \mathbf{V} > 0$ means fluid is expanding (like a source) at that point, < 0 means it's converging (like a sink). In incompressible fluid flow, $\nabla \cdot \mathbf{V} = 0$ everywhere (volume is conserved).

- **Curl:** For a vector field in 3D, the **curl** is a vector $\nabla \times \mathbf{V}$ that represents the rotation or swirling of the field. Its components are given by certain differences of partials (formally $\nabla \times \mathbf{V} = \langle \partial V_z/\partial y - \partial V_y/\partial z,\ \partial V_x/\partial z - \partial V_z/\partial x,\ \partial V_y/\partial x - \partial V_x/\partial y \rangle$). If $\nabla \times \mathbf{V} = \mathbf{0}$, the field is irrotational (no local spin). In mechanical engineering, curl might come up conceptually with rotational flows or when applying Stokes' theorem (though that's more advanced than FE usually tests).

- **Multiple Integrals:** A **double integral** $\iint_R f(x, y)\, dx\, dy$ calculates the volume under the surface $z = f(x, y)$ above a region R in the xy-plane. It's like summing up infinitesimal columns of volume. To compute, you often integrate iteratively: $\int_{y=y_1}^{y_2} \int_{x=x_1}^{x_2} f(x, y)\, dx\, dy$. Order can matter if limits are not constant (use whichever order makes integration easier or follow given limits). A **triple integral** $\iiint f(x, y, z)\ dV$ accumulates a quantity in a 3D region, e.g. total mass in a volume given a density function $f(x, y, z)$. Multiple integrals are used for finding areas, volumes, centroids (by integrating x or y times density), and moments of inertia. The FE exam might involve setting up a double integral for an area or using given formulas (from the handbook) for common shapes rather than performing heavy integration. But you should know the notation and basic idea that $\iint_R 1\ dx\, dy$ gives area of region R, and $\iint_R f(x, y)\, dx\, dy$ weighs f over that area.

- **Integration Order and Conversions:** You might see integrals in different coordinates. Cartesian double integrals $\iint_R f(x, y) dxdy$ can sometimes be converted to polar coordinates ($x = r\cos\theta, y = r\sin\theta$) where $dx\, dy = r\, dr\, d\theta$. This is useful if R is a circular region. Similarly, triple integrals might use cylindrical or spherical coordinates with their Jacobian factors (provided in the handbook). For FE Mechanical, direct use of polar/spherical integration is less common unless the problem specifically guides you (like finding volume of a sphere via an integral).

Exam Handbook Search Cues (Not affiliated with or endorsed by NCEES): *partial derivative, gradient, multivariable, chain rule (in partial context), divergence, curl, double integral, Jacobian.* (The handbook's Mathematics section includes "The Partial Derivative" definition and a blurb on Gradient, Divergence, Curl. It also covers double integrals in the context of geometry/volume formulas indirectly. Use keywords like "Gradient" or "∇" to find vector calc identities, and "∬" for multiple integrals if needed.)

Equation/Definition Passport – Gradient & Related Operators: *Summarizes how to differentiate scalar and vector fields in multiple dimensions.*

Partial Derivative (∂):

$\frac{\partial f}{\partial x}(x, y, z) =$ derivative of $f(x, y, z)$ with respect to x, treating y, z as constants. (Likewise, for $\partial f/\partial y,\ \partial f/\partial z$.) It's like taking a slice of the function along the x-direction and finding that slope. For example, if $f(x, y) = x^2 + 3xy$, then $f_x = 2x + 3y$ and $f_y = 3x$.

Gradient (∇f):

$\nabla f = \left\langle \frac{\partial f}{\partial x}, \frac{\partial f}{\partial y}, \frac{\partial f}{\partial z} \right\rangle$. In 2D, $\nabla f = \langle f_x,\ f_y \rangle$

It forms a vector field from a scalar field.

- *Units:* If f has units U, and coordinates x, y, z have units X, Y, Z respectively, then components of ∇f have units $U/X,\ U/Y,\ U/Z$. (E.g. temperature gradient K/m.)
- *Interpretation:* ∇f points toward increasing f. If you move a tiny bit in direction of ∇f, f increases fastest. If you move perpendicular to ∇f, f doesn't change to first order (that direction is along a level curve/surface). On a hill, the gradient of elevation is pointing uphill; walking exactly perpendicular to that (along the contour) keeps you at same height initially.
- *Use vs. Siblings:* Use ∇f when you need the slope in multiple directions or want to optimize a multivariable function. Setting ∇f = 0 finds critical points (candidates for maxima/minima or saddle points) in multiple dimensions. This is analogous to setting derivative = 0 in single-variable.
- *Common exam traps:* Notation confusion – ∇f is a vector, whereas ∂f/∂x is a scalar. Also, mixing up ∇f with ∇·f (the latter is not standard; ∇· requires a vector input). Another trap: forgetting to hold other variables constant – e.g. treating y as a function of x when taking ∂/∂x, which you should not unless explicitly a function (then use total derivative via chain rule).

Divergence ($\nabla \cdot \mathbf{V}$):

$\nabla \cdot \langle P, Q, R \rangle = \frac{\partial P}{\partial x} + \frac{\partial Q}{\partial y} + \frac{\partial R}{\partial z}$

In 2D for $\mathbf{V} = \langle P, Q \rangle$, it's $P_x + Q_y$

- *Interpretation:* Scalar output. Positive divergence at a point means vectors are "flowing out" (source), negative means "flowing in" (sink). In FE contexts, you might use divergence implicitly: for instance, the continuity equation for steady incompressible flow $\partial u/\partial x + \partial v/\partial y + \partial w/\partial z = 0$ is saying divergence of velocity = 0. The exam could ask something like "which expression represents conservation of mass for incompressible flow?" expecting you to identify that divergence form.
- *Units:* If **V** is velocity (m/s), ∇·V has units of 1/s (rate of volume change per volume, sort of).

Curl ($\nabla \times \mathbf{V}$):

$\nabla \times \langle P, Q, R \rangle = \left\langle \frac{\partial R}{\partial y} - \frac{\partial Q}{\partial z}, \frac{\partial P}{\partial z} - \frac{\partial R}{\partial x}, \frac{\partial Q}{\partial x} - \frac{\partial P}{\partial y} \right\rangle.$

(You can remember via the determinant mnemonic with unit vectors i,j,k in the top row.) In 2D, sometimes we talk of "curl" as a scalar $(\partial Q/\partial x - \partial P/\partial y)$ which corresponds to the k-component (out-of-plane) of the 3D curl vector for a field $\langle P, Q, 0 \rangle$.

- *Interpretation:* The curl is a vector that points along the axis of rotation (given by right-hand rule) of the field, with magnitude equal to the local rotation strength. For example, if **V** is velocity in a fluid, curl V is essentially twice the local angular velocity vector (this relates to vorticity). If curl = 0 everywhere, the field is *conservative* (which means it can be expressed as ∇f of some scalar potential).
- *Note:* In mechanical, you rarely calculate curl explicitly, but being aware of it helps in fluid dynamics and understanding fields. For FE, just know that ∇× applied to a vector gives another vector, often testing if something is irrotational.

Variations & Related Concepts:

- **Higher-Order Partials:** You can take second partial derivatives like $f_{xx} = \frac{\partial^2 f}{\partial x^2}$, $f_{xy} = \frac{\partial^2 f}{\partial y\, \partial x}$, etc. A key fact: if f has continuous second derivatives, $f_{xy} = f_{yx}$ (Clairaut's theorem on equality of mixed partials). On the exam, you might use this if needed to simplify a calculation or verify a relationship.
- **Chain Rule (Multivariable):** If variables are interdependent, the chain rule extends. For example, if $z = f(x, y)$ with $x = g(t), y = h(t)$ (so z ultimately a function of t), then $\frac{dz}{dt} = f_x \frac{dx}{dt} + f_y \frac{dy}{dt}$. This comes up if you need the rate of change of something that depends on two changing inputs. Another common scenario: total derivative in thermodynamics (like $dU = \frac{\partial U}{\partial T} dT + \frac{\partial U}{\partial V} dV$). Recognize when to sum partial effects.
- **Multiple Integrals Order:** The ability to switch integration order: $\int_{x=a}^{b} \int_{y=c}^{d} f(x, y)\, dy\, dx = \int_{y=c}^{d} \int_{x=a}^{b} f(x, y)\, dx\, dy$, provided the limits are constant and region is a rectangle. For general regions, the limits change accordingly if you swap. The FE might supply an iterated integral and ask you to interpret it or possibly switch order; ensure you understand the region of integration from the bounds. Also, *line integrals* and *surface integrals* are advanced topics likely beyond FE Mechanical scope except conceptually in potential field work/energy context (like a line integral of force along a path is work).
- **Gradient and Optimization:** Setting ∇f = 0 in 2D yields equations $f_x = 0, f_y = 0$, which you solve simultaneously to find critical points (like peaks or valleys on a surface). After finding a critical point, you'd use the second derivative test for functions of two variables (involving f_{xx}, f_{yy}, f_{xy}) to classify it as local max, min, or saddle. While detailed classification might not be directly tested, you should know that ∇f=0 is a necessary condition for an optimum (just like f'=0 in 1D).
- **Physical Interpretation Recap:** Partial derivatives appear in many engineering formulas (e.g. partial derivative of volume with respect to temperature at constant pressure is related to thermal expansion coefficient in thermo). The gradient appears in heat transfer (Fourier's law: heat flux = -k ∇T), where ∇T drives heat flow direction. Divergence appears in fluid flow and heat equations (continuity and Gauss's law type relations). Curl appears in rotational systems (though more in fluids and electromagnetics).
- **Units and Notation:** Keep track: using ∂ vs d. For example, $df = f_x dx + f_y dy$ is a total differential, consisting of partial derivatives and differentials. In the exam reference, you might see something like $d(pV) = p\, dV + V\, dp$ which is an application of product rule with differentials – implicitly partial derivatives holding one variable constant at a time.

Special Notes: There is no special calculator function for partial derivatives or gradient (since these are symbolic operations). If a question gives numerical values for partial derivatives and increments dx, dy, you could plug into the linear approximation $dz \approx f_x dx + f_y dy$. But typically, you'll handle partial differentiation by hand using normal differentiation rules on one variable at a time. The exam's on-screen handbook can assist if you forget vector calculus formulas: searching "Gradient" or "Curl" will show those definitions in the math section. Just remember ∇ (nabla) is the symbol representing the vector of partial derivative operators $\langle \partial/\partial x, \partial/\partial y, \partial/\partial z \rangle$. Applying it with a dot or cross to fields triggers divergence or curl respectively. These concepts can feel abstract; tying them to physical intuition (as we did above) can help ensure you apply them correctly if needed.

Explanation (Putting Multivariable Calculus to Use): On exam problems, multivariable calculus might manifest in several ways. You could be asked to *compute a partial derivative* from a given formula: for instance, "Given $z = x^2 e^{3y}$, find $\partial z/\partial y$." You would treat x^2 as a constant and differentiate e^{3y} to get $3e^{3y}$, thus $\partial z/\partial y = x^2 \cdot 3e^{3y} = 3x^2 e^{3y}$. Another common use is in **max/min problems** for functions of two variables: maybe finding the dimensions x, y that maximize area or minimize cost given some function $f(x, y)$. You'd set $f_x = 0, f_y = 0$ to find critical points. For example, maximizing $A(x, y) = xy$ given a perimeter constraint $2x + 2y = P$ would involve expressing $y = (P/2 - x)$ and then doing a single-variable derivative, but you could also set up Lagrange multipliers (a method from multivariable calculus involving ∇). Lagrange multipliers likely won't be explicitly tested

by name in FE Mechanical, but understanding that $\nabla f = \lambda \nabla g$ is the condition for constrained extrema can be useful if you remember it (it's essentially how you'd solve optimization with constraints elegantly). For **multiple integrals**, you might not have to grind through a double integral unless it's simple. More often, a problem could give an already integrated result or require interpreting an integral. For instance, "$\int_0^2 \int_0^3 5\ dx\, dy$" – conceptually, that's the volume under $f(x,y) = 5$ over a 2 by 3 rectangle, which equals $5 * 2 * 3 = 30$. Or you might get a problem asking the centroid of a 2D shape: you'd recall $\bar{x} = \frac{1}{A}\iint_R x\ dA$ and likely use known formulas for common shapes instead of doing full integration, but the concept is rooted in double integrals. If a double integral is required, break it into iterated one-dimensional integrals and integrate stepwise. For example, $\int_{y=0}^{1} \int_{x=0}^{y} (x+2y)\ dx\, dy$ – you integrate inner ∫ dx first (treat y const while integrating $x + 2y$ in x), then integrate that result in y. If the order is inconvenient, consider swapping integration order *if* that makes the bounds nicer, but ensure to adjust the limits carefully by describing region R in the opposite way. Finally, vector calculus operations like divergence and curl might appear in conceptual questions (like identifying an expression as divergence of something, or recognizing that curl of gradient is always zero, i.e. $\nabla \times (\nabla f) = 0$). One could imagine a question: "Which of the following is always true for a well-behaved scalar field $f(x,y,z)$? (A) ∇×(∇f) = 0, (B) ∇·(∇f) = 0, ..." The correct statement is (A). Recognizing these identities can be handy. Similarly, ∇·(∇×V) = 0 always (divergence of any curl is zero). Such identities might help simplify certain expressions in advanced problems, though rarely needed for mechanical fundamentals. But if you see a complicated expression, sometimes knowing it equals zero by vector calc identity can save time.

Analysis (Term-by-Term in Gradient & Integrals): Let's dissect a sample problem to cement these ideas. Say we have $u(x,y) = 3x^2y - 4y + 7$. Partial derivatives: $u_x = 6xy$ (because $d(3x^2y)/dx = 6xy$, $d(-4y)/dx = 0$), and $u_y = 3x^2 - 4$. The gradient is $\nabla u = \langle 6xy,\ 3x^2 - 4\rangle$. If we set ∇u = 0: from $6xy = 0$ we get either $x = 0$ or $y = 0$; from $3x^2 - 4 = 0$ we get $x = \pm\frac{2}{\sqrt{3}}$. Combining: for critical point, both must hold, so $x = 0$ or $y = 0$ from first equation. If $x = 0$, second eq gives $-4 = 0$ which is impossible, so no solution from x=0. If $y = 0$, second gives $3x^2 - 4 = 0$ so $x = \pm 2/\sqrt{3}$. Thus two critical points: $\left(2/\sqrt{3}, 0\right)$ and $\left(-2/\sqrt{3}, 0\right)$. We'd then classify via second derivative test or plug into u: u is a downward-opening parabola in x for any fixed y (because $u_x x = 6y$, oh actually $u_x x = 6y$; at those points y=0 so $u_x x = 0$, hmm inconclusive in that direction; better use the full Hessian test not discussed here). But likely a problem would ask just for the critical points or which yields a max/min if obvious. For multiple integrals, consider a double integral example: $\iint_R (x+2y)\ dA$ where R is the triangle with vertices (0,0), (2,0), (2,2). We can set it up as y from 0 to x (because line from (2,0) to (2,2) is x=2, and line from (0,0) to (2,2) is y=x), and x from 0 to 2. So $\int_{x=0}^{2} \int_{y=0}^{y=x} (x+2y)\ dy\, dx$. Compute inner: ∫(x+2y) dy = x y + y^2 | from y=0 to y=x = $x * x + x^2 - 0 = 2x^2$. Now outer: $\int_0^2 2x^2 dx = [2 * x^3/3]_0^2 = 2 * 8/3 = 16/3$. That result is the volume under z=x+2y over that triangular region. We could have swapped integration: describe R as x from y to 2, y from 0 to 2 (solving y=x → x=y for lower x bound). Doing so yields the same result if done correctly. An FE problem might not have you do all this integration but could give intermediate steps and ask, for instance, which integral setup corresponds to the given region or which of multiple expressed integrals equals a certain value. Finally, let's parse a vector calc identity: take $f(x,y,z) = x^2 + y^2 + z^2$ (distance squared from origin). ∇f = ⟨2x, 2y, 2z⟩ . That's a radial field. Curl of this gradient is 0: $\nabla \times \nabla f = 0$ which you can verify quickly (the partial derivatives will cancel). Divergence of ∇f is ∇ · ($\langle 2x, 2y, 2z\rangle$) $= 2 + 2 + 2 = 6$. That equals $\nabla^2 f$ (the Laplacian of f), which in this case is constant. These calculations show how each operation works term-by-term: gradient took derivatives of each component, divergence summed certain derivatives, curl took differences. Each partial derivative was straightforward. The power of these operators is more apparent in general theory, but computationally they reduce to repeated partial differentiation and combination. Just be systematic, and use the handbook if needed for formula recall.

At-a-Glance Summary (Multivariable Calculus Tools):

Concept & Notation	Definition/Formula	Meaning in words / units
Partial derivative $\frac{\partial z}{\partial x}$ [4]	Differentiate $f(x,y,\ldots)$ w.rt x treating other variables as constants.	Slope of f in the x-direction (holding others fixed). Units: "units of f per unit of x" (e.g. if f is pressure Pa and x is volume m³, $\partial f / \partial x$ in Pa/m³).
Gradient ∇f	$\langle f_x,\ f_y,\ f_z\rangle$ (vector of all first partials). In 2D, $\nabla f = \langle f_x, f_y\rangle$.	A vector pointing in direction of greatest increase of f. Its magnitude is the steepest slope. Often called "grad f". Units: same as partials but as a vector.
Divergence $\nabla \cdot \mathbf{V}$	For $\mathbf{V} = \langle P, Q, R\rangle$: $P_x + Q_y + R_z$. (Sum of partials of components.)	Scalar indicating how **V** spreads. "Flux density." If positive, field is emanating (source); if negative, converging (sink). Zero means incompressible/volume-conserving flow if **V** is velocity.
Curl $\nabla \times \mathbf{V}$	$\langle R_y - Q_z,\ P_z - R_x,\ Q_x - P_y\rangle$. (Determinant form with unit vectors i,j,k helps memory.)	A vector representing rotation or swirling of **V**. Direction of curl = axis of rotation (right-hand rule), magnitude = rotation strength. For 2D fields (P,Q,0), curl points out-of-plane $(Q_x - P_y)\mathbf{k}$.
Double integral $\iint_R f(x,y)\, dA$	$\int_{y=y_1}^{y_2} \int_{x=x_1}^{x_2} f(x,y)\, dx\, dy$ or appropriate limits describing region R.	Accumulates f over area R. If $f = 1$, gives area of R. If $f(x,y)$ is a density (e.g. kg/m²), the integral gives total mass over R. Units: (units of f) × (area units).
Triple integral $\iiint_V f(x,y,z)\, dV$	$\int\int\int_V f(x,y,z)\ dx\, dy\, dz$. Can be evaluated in any order with proper limits, or converted to cylindrical/spherical if symmetric.	Accumulates f through a volume V. If $f = 1$, yields volume of region. Commonly used for total mass (with f as density in kg/m³ → result in kg).

Topic 03 - Ordinary Differential Equations

Topic Introduction: Ordinary Differential Equations (ODEs) model how quantities change and interact over one independent variable (like time). On the **FE Mechanical Exam**, you'll encounter ODE questions that test your grasp of system dynamics and solution methods. Why do ODEs matter on exam day? Because many mechanical phenomena – from heat cooling (first-order decay) to vibration of a mass-spring-damper (second-order oscillation) – are governed by differential equations. The typical FE exam question gives a straightforward ODE or initial-value problem and asks for the solution or behavior (decay rate, oscillation frequency, steady-state value, etc.). Mastering the core methods to solve linear ODEs will let you quickly recognize solution patterns and avoid wasting time. In this chapter, we focus on the essentials: formulating linear ODEs, solving constant-coefficient cases (using characteristic equations), and leveraging Laplace transforms to simplify ODE problems.

K01.T03.S01 – Formulation and Solutions of Linear ODEs (Homogeneous and Particular Solutions)

Principle Introduction: *Linear ODEs* are differential equations where the dependent variable and its derivatives appear linearly (no powers or products of y, y', y'', etc.). Key ideas for linear ODEs include:

- **Superposition:** The general solution of a linear ODE is the sum of the *homogeneous solution* (solving the equation with zero forcing) and a *particular solution* (accounting for the forcing function present).
- **Homogeneous vs. Nonhomogeneous:** A *homogeneous* ODE has no external forcing term (i.e., set equal to 0), while a *nonhomogeneous* ODE includes a forcing function $f(x)$. The homogeneous equation's solutions form the "natural response" of the system.
- **General Solution Structure:** Solve the homogeneous part first, then find one particular solution for the nonhomogeneous part. Any particular solution works because adding any homogeneous solution (which solves the zero-forcing case) still satisfies the nonhomogeneous equation due to linearity.
- **Initial Conditions:** Unique solutions arise when initial or boundary conditions are applied to the general solution. The constants of integration (from the homogeneous solution) are determined by these conditions, ensuring the solution fits the specific scenario.
- **Linearity Benefits:** By linearity, if $y_1(x)$and $y_2(x)$solve the homogeneous equation, then any combination $C_1y_1(x) + C_2y_2(x)$is also a solution. This is why the homogeneous solution is written as a sum of such terms.

Exam Handbook Search Cues (Not affiliated with or endorsed by NCEES): *differential equations; homogeneous; particular solution; characteristic polynomial; forcing function*

Footnotes:
- *Scope:* FE problems on ODEs typically involve linear ODEs with constant coefficients. Nonlinear ODEs or complicated variable-coefficient cases are beyond the exam scope (except simple separable cases in calculus contexts).
- *Notation:* We often denote the homogeneous solution as $y_h(x)$ and a particular solution as $y_p(x)$. The general solution is $y(x) = y_h(x) + y_p(x)$.
- *Resonance:* If the forcing term $f(x)$ shares a form with a homogeneous solution term (e.g. forcing is e^{rx} where r is a root of the characteristic equation), a special "resonant" particular solution (multiplied by x) is needed – see Subtopic 2 for details.
- *Units:* In a pure math context, x and y can be unitless. In physical problems, x might be time (seconds) or position, and coefficients ensure each term in the ODE has consistent units. Always check that adding terms is dimensionally valid.

Variations and Related Forms: Linear ODEs can have constant or variable coefficients. The FE Exam emphasizes constant coefficients (covered in Subtopic 2). If coefficients vary with x (e.g. $y' + p(x)y = q(x)$), methods like integrating factors are used. Additionally, first-order ODEs might be *separable* (able to isolate y and x sides) – those are typically handled in calculus problems rather than here.

Special Notes (Calculator Tips): For constant-coefficient ODEs, you may need to solve for roots of a polynomial (the characteristic equation). FE-approved calculators (like the TI-36X Pro or Casio fx-115/991 series) have polynomial solvers for quadratic (and sometimes cubic) equations. You can use these to quickly find roots, then write down the solution form. However, be cautious: calculators typically give real roots only – if a quadratic has complex roots, you'll need to recognize that from a negative discriminant (the calculator might show an error or just not display complex results).

Explanation & Analysis (Step-by-Step): To solve a linear ODE on the exam, follow this general procedure:

1. **Identify the Equation Type:** Confirm it's linear. Standard form for an nth-order linear ODE is
$$b_n \frac{d^n y}{dx^n} + b_{n-1} \frac{d^{n-1} y}{dx^{n-1}} + \cdots + b_1 \frac{dy}{dx} + b_0 y(x) = f(x),$$
where coefficients b_i may be constants (common in FE problems). If $f(x) = 0$, it's homogeneous; otherwise, nonhomogeneous.
2. **Solve the Homogeneous Part:** Set $f(x) = 0$ and solve $b_n y^{(n)} + \cdots + b_0 y = 0$. For constant coefficients, assume solutions of form $y = e^{rx}$ to get the *characteristic polynomial* $P(r) = b_n r^n + \cdots + b_0 = 0$. Solve for roots r_i. Construct the homogeneous solution as
$$y_h(x) = C_1 e^{r_1 x} + C_2 e^{r_2 x} + \cdots,$$
using one term per distinct root (see Subtopic 2 for repeated or complex root cases).
3. **Find a Particular Solution:** Propose a form of $y_p(x)$ that resembles the forcing function $f(x)$. This is the Method of Undetermined Coefficients: for example, if $f(x)$ is a polynomial, guess a polynomial y_p of similar degree; if $f(x)$ is $Ae^{\alpha x}$, try $y_p = Ke^{\alpha x}$; if $f(x)$ is sinusoidal $A\sin\omega x + B\cos\omega x$, try $y_p = M\sin\omega x + N\cos\omega x$. **Adjust for resonance:** If your guess overlaps with any part of $y_h(x)$, multiply by x enough times to create an independent form. (For instance, if solving $y'' + 4y = e^{2x}$ and the homogeneous solution already has an e^{2x} term, try $y_p = Kxe^{2x}$ instead.)
4. **Sum Up General Solution:** Write $y(x) = y_h(x) + y_p(x)$. This combined solution covers all possible behaviors of the ODE. At this stage, include any arbitrary constants from y_h.

5. **Apply Initial/Boundary Conditions:** Plug in the given initial conditions (values of y and its derivatives at a certain point, usually $x = 0$ or $t = 0$) to solve for the constants $C_1, C_2, \ldots$. For example, if $y(0)$ and $y'^{(0)}$ are given, substitute $x = 0$ into $y(x)$ and $y'^{(x)}$ to get equations for the constants. Solve these equations to finalize the specific solution.
6. **Interpret the Solution:** Ensure the solution makes sense physically (if applicable). Check special cases: if the forcing $f(x)$ were zero, does your solution reduce to the pure homogeneous solution? If time goes to infinity, does $y(t)$ approach a reasonable limit (like zero for a stable system or some steady state if forcing is constant)?

Analysis – Term by Term: In the general ODE

$$b_n y^{(n)} + b_{n-1} y^{(n-1)} + \cdots + b_1 y' + b_0 y = f(x),$$

each term $b_k y^{(k)}$ represents how the kth derivative contributes, scaled by coefficient b_k. For example, in a second-order system (like $my'' + cy' + ky = 0$ in mechanics), the terms correspond to inertia (my''), damping (cy'), and stiffness (ky). The forcing $f(x)$ drives the particular solution. Because the equation is linear, if you set $f(x) = 0$, the remaining homogeneous equation's solutions can be superimposed to also solve the nonhomogeneous case's homogeneous part. The *homogeneous solution* y_h captures the system's natural response (think "free vibration" or "natural decay" with no input), while y_p is a specific solution that makes up for the forcing (think "steady forced response"). Common mistakes include: forgetting to add the homogeneous solution to the particular solution (thus missing the general solution), or choosing a poor form for $y_p(x)$ (for example, guessing Ke^{2x} for $f(x) = 5e^{2x}$ when e^{2x} already solves the homogeneous part – you need Kxe^{2x} in that case).

Equation Passport: General Linear ODE – Complete solution of an nth-order linear ODE as sum of homogeneous and particular parts.

General Form:

$$b_n \frac{d^n y}{dx^n} + b_{n-1} \frac{d^{n-1} y}{dx^{n-1}} + \cdots + b_1 \frac{dy}{dx} + b_0\, y(x) = f(x).$$

Complete Solution: $y(x) = y_h(x) + y_p(x)$.

Variables: x – independent variable (often time t in seconds); $y(x)$ – dependent variable (function of x, units vary by context) $b_n, b_{n-1}, \ldots, b_0$ – constant coefficients (given; units such that each term has consistent units) $f(x)$ – forcing function (the input or nonhomogeneous term; same units as left side)

Assumptions: Equation is linear with constant coefficients (methods here assume coefficients don't depend on x). Valid for ordinary (single-variable) differential equations. Superposition applies (principle of linearity).

Limit Checks: If $f(x) = 0$ (no forcing), then $y_p(x) = 0$ and $y(x) = y_h(x)$ – the solution decays or oscillates according to the homogeneous dynamics alone. If all coefficients except b_0 were zero, the ODE reduces to $b_0 y = f(x)$ (algebraic form), and $y_p = f(x)/b_0$ would be a particular solution.

Use vs. Sibling Methods: Use this linear ODE framework instead of nonlinear methods when the equation is linear. (Nonlinear ODEs require different techniques beyond the FE exam's scope.) For constant coefficients, use the characteristic equation method (see K01.T03.S02). For variable coefficients in first-order, an integrating factor method is the sibling technique (used when b_n is not constant or when solving e.g. $y' + p(x)y = q(x)$).

Common Exam Traps: Not adding the homogeneous solution to the particular solution (losing the general solution). Choosing an incorrect particular solution form (especially when $f(x)$ "resonates" with a homogeneous term). Algebraic mistakes in solving for constants with initial conditions (e.g., sign errors or forgetting to plug initial values into both y and y' correctly). Neglecting units: ensure that if you plug numerical values, units remain consistent, though most ODE questions focus on form rather than actual units.

K01.T03.S02 – Solutions of Constant-Coefficient ODEs (Characteristic Equations for Common Forms)

Principle Introduction: When an ODE has **constant coefficients**, we can solve the homogeneous part using the *characteristic equation*. This is a polynomial equation obtained by substituting a trial solution $y = e^{rx}$. The result is an algebraic equation $P(r) = 0$ whose roots r_i determine the form of the homogeneous solution. Common ODE forms on the FE exam include first-order and second-order cases:

- **First-Order (Linear, Constant Coefficient):** $y' + a\,y = 0$. The characteristic equation is $r + a = 0$, giving root $r = -a$. Solution: $y_h(t) = Ce^{-at}$. If there's a constant or other forcing, a particular solution is usually a constant or matching form (e.g., for $y' + ay = K$ the steady-state particular solution is $y_p = K/a$). This captures processes like exponential decay or growth with time constant $1/a$.
- **Second-Order (Constant Coefficients):** $y'' + a\,y' + b\,y = 0$. Characteristic equation: $r^2 + ar + b = 0$. The nature of the two roots $r_{1,2}$ (solutions of this quadratic) leads to three cases:
- **Distinct real roots** ($a^2 > 4b$): Two different real solutions r_1, r_2. Homogeneous solution: $y_h(t) = C_1 e^{r_1 t} + C_2 e^{r_2 t}$. In mechanical terms, this is an overdamped response (no oscillation, just two exponential decays).
- **Repeated real root** ($a^2 = 4b$): A double root r. Homogeneous solution: $y_h(t) = (C_1 + C_2\, t)e^{rt}$. This occurs at critical damping in mechanical systems – the system returns to equilibrium as fast as possible without oscillating.
- **Complex conjugate roots** ($a^2 < 4b$): Roots $r = \alpha \pm j\,\beta$, with $\alpha = -\frac{a}{2}$ and $\beta = \frac{\sqrt{4b-a^2}}{2}$. Homogeneous solution: $y_h(t) = e^{at}(C_1 \cos\beta t + C_2 \sin\beta t)$. This underdamped case yields oscillatory behavior at natural frequency β (rad/s), with exponential decay rate $|\alpha|$. Think of a lightly damped spring-mass vibrating.
- **Higher-Order:** Higher than second order is less common in FE questions, but the same principle extends: solve $P(r) = 0$ (a cubic, quartic, etc.). For instance, a third-order ODE yields three roots and the homogeneous solution is $y_h = C_1 e^{r_1 x} + C_2 e^{r_2 x} + C_3 e^{r_3 x}$ (or with polynomial factors for any repeated roots). In practice, the exam usually restricts to cases where solving the polynomial is feasible (quadratic formula or factoring).

Once the homogeneous solution is determined, incorporate particular solutions for any forcing term, as discussed earlier.

Method of undetermined coefficients provides specific guess patterns for typical $f(x)$ forms (constants, exponentials, sines/cosines, polynomials). For example, for $y'' + ay' + by = F\sin\omega t$, you'd guess $y_p = A\sin\omega t + B\cos\omega t$.

Exam Handbook Search Cues (Not affiliated with or endorsed by NCEES): *first-order linear ODE; second-order linear homogeneous; constant coefficients; characteristic equation; quadratic formula; repeated roots; underdamped/overdamped*

Second-Order Homogeneous Responses – Solutions $y(t)$ of $y'' + a\,y' + 1 \cdot y = 0$ for three damping cases (all with initial condition $y(0) = 1,\ y'^{(0)} = 0$).

Underdamped (low a): oscillatory decay (orange curve, $a = 0.5$).

Critically Damped ($a^2 = 4b$): fastest non-oscillatory decay (green curve, $a = 2.0$).

Overdamped (high a): slow exponential decay without oscillation (red curve, $a = 3.0$). Notice underdamped solutions cross zero and oscillate with decreasing amplitude, whereas critically and overdamped cases do not oscillate (no sign change) and simply return to zero at different rates.

Exam Handbook Search Cues (Not affiliated with or endorsed by NCEES): *first-order homogeneous; second-order characteristic; repeated root; distinct roots; damping ratio (Note: The exam reference might list these cases under differential equations with constant coefficients. Search by keywords like "first-order linear homogeneous" or "second-order linear…constant coefficients" to find the formulae and case distinctions.)*

Footnotes:

- *Damping Terms:* In mechanical vibrations, the standard form $y'' + 2\zeta\omega_n y' + \omega_n^2 y = 0$ introduces the damping ratio ζ (zeta) and natural angular frequency $\omega_n = \sqrt{b}$. In the form $y'' + ay' + by = 0$, we have $a = 2\zeta\omega_n$ and $b = \omega_n^2$. Overdamped corresponds to $\zeta > 1$ ($a^2 > 4b$), critical to $\zeta = 1$ ($a^2 = 4b$), and underdamped to $\zeta < 1$. You don't need to use ζ on the exam unless a question explicitly references damping ratio, but it's good to recognize the correspondence.

- *Repeated Root Handling:* For each repeated root of multiplicity m, the homogeneous solution gets polynomial factors up to t^{m-1}. For example, if $r = 5$ is a double root, solutions e^{5t} and te^{5t} arise. If it were triple, $e^{5t}, te^{5t}, t^2e^{5t}$ would appear, and so on.

- *Characteristic Polynomial Zeros:* The sum and product of roots relate to coefficients (for quadratic: $r_1 + r_2 = -a, r_1r_2 = b$). This can sometimes speed up solving if you can factor by inspection.

- *Units Check:* If x is time, coefficient a has units of 1/time, and b has units of 1/time², so that $a\,y'$ and $b\,y$ both have units of y'' (which is y/time²). This consistency check can help ensure you assembled the ODE correctly from a physical problem.

Variations, Related Forms, Typical Values: In some cases, the ODE might be given in a slightly different form, such as $\tau\frac{dy}{dt} + y = K\,u(t)$ which is a first-order system with time constant $\tau = 1/a$ and gain K. The solution to this (for a step change in input $u(t)$ from A to B) is $y(t) = K\,B + (y(0) - K\,B)e^{-t/\tau}$. This aligns with the general solutions above (here $a = 1/\tau$, so $y' + \frac{1}{\tau}y = \frac{K}{\tau}u(t)$). Typical values of time constants or frequencies depend on the system (not tested numerically on the FE, but you should recognize if an answer should decay faster/slower qualitatively). For constant coefficient ODEs, expect the exam to give "nice" numbers – e.g., roots that are integers or simple fractions, or a quadratic that factors cleanly or uses a simple square root.

Special Notes (Calculator Usage): As mentioned, use your calculator's polynomial solver for quadratic characteristic equations when possible to avoid algebra errors. For example, on the TI-36X Pro, use the Poly solver mode, input coefficients 1 (for r^2), a (for r), b (constant), and it will output r_1, r_2. If the roots are complex, the calculator might indicate a math error or show no real solutions; you then know it's the underdamped case and can proceed accordingly by hand with the complex form. For repeated roots, the poly solver will show the same root twice (e.g., $r = -2, -2$ for a double root at -2). Always double-check that you pair the correct solution form to the type of roots you got.

Explanation & Analysis (Step-by-Step): Let's walk through solving a constant-coefficient ODE, focusing on the homogeneous solution since that's where the characteristic equation is used:

1. **Write the Characteristic Equation:** For the homogeneous ODE $y'' + ay' + by = 0$, write $r^2 + ar + b = 0$. This quadratic comes from assuming $y = e^{rt}$ and canceling the nonzero exponential factor. For a first-order ODE $y' + ay = 0$, the characteristic equation is simply $r + a = 0$.
2. **Solve for Roots r_i:** Use the quadratic formula for second-order:
   $r_{1,2} = \frac{-a \pm \sqrt{a^2 - 4b}}{2}$.
   Identify the nature of the roots:
   If $a^2 - 4b > 0$, two distinct reals (you'll get two different numeric answers).
   If $a^2 - 4b = 0$, a repeated real (both answers same value r).
   If $a^2 - 4b < 0$, complex conjugates (the calculator won't give these directly in real mode, so deduce that $r = \alpha \pm j\beta$ where $\alpha = -a/2$, $\beta = \frac{\sqrt{4b - a^2}}{2}$).
3. **Write Homogeneous Solution $y_h(t)$:** Use the root information:
   Distinct reals: $y_h = C_1e^{r_1t} + C_2e^{r_2t}$.
   Repeated real: $y_h = (C_1 + C_2t)e^{rt}$.
   Complex pair: with $r = \alpha \pm j\beta$, write $y_h = e^{\alpha t}(C_1\cos\beta t + C_2\sin\beta t)$. *(Remember:* even if you haven't seen complex numbers in a while, the key is that the real solution will involve sinusoids).
4. **Include Particular Solution if Nonhomogeneous:** If the full ODE was $y'' + ay' + by = f(t)$ (nonzero right-hand side), now find a particular solution $y_p(t)$ using an ansatz that fits $f(t)$. For example, if $f(t) = F_0$ (constant), try $y_p = K$ (a constant). If $f(t) = F_0e^{\gamma t}$, try $y_p = Ke^{\gamma t}$ (unless γ equals a root, in which case try $Kte^{\gamma t}$). If $f(t) = F_0\cos\omega t$, try $y_p = A\cos\omega t + B\sin\omega t$.
5. **Add General Solution and Apply Conditions:** Combine $y = y_h + y_p$. Then, given initial conditions like $y(0)$ and $y'^{(0)}$, solve for the constants C_1, C_2, etc. This is straightforward algebra: plug $t = 0$ (and maybe also differentiate and plug $t = 0$) to match the initial values.
6. **Check the Behavior:** It helps to qualitatively check your solution's behavior against what you expect:
7. Does your solution blow up or oscillate? (On the exam, physical systems usually decay or oscillate stably; if you

found a growing exponential, re-check the sign on your root.)

8. For large t, if the system is damped (stable), y_h terms should decay to 0. The particular solution y_p often approaches the steady state (like KB in the step response example). Verify that as $t \to \infty$, $y(t)$ approaches a finite value (or 0 if forcing is zero or transient).
9. If you have complex roots, ensure your final answer is real-valued (the sine and cosine form ensures this). If you accidentally wrote something like $e^{(\alpha+j\beta)t}$ alone, convert it to cos/sin form.

Analysis – Understanding Terms: Each term in the homogeneous solution corresponds to a *mode* of the system: - A real root $r < 0$ gives a decaying exponential mode. $r > 0$ (not common in exam contexts unless a trick question) would mean a growing exponential (unstable system). - A repeated root mode e^{rt} and te^{rt} indicates a critically damped boundary between oscillatory and non-oscillatory behavior. - Complex roots yield oscillatory modes $e^{\alpha t}\cos\beta t$ and $e^{\alpha t}\sin\beta t$, where $\alpha < 0$ is a damping factor (decay rate) and β is the oscillation frequency. No real exponential can capture an oscillation by itself; it requires the combination shown. The particular solution's terms mirror the forcing function. For instance, a constant force produces a constant steady response; a sinusoidal force produces a sinusoidal particular solution (of the same frequency, possibly phase-shifted); an exponential forcing yields an exponential particular solution of the same exponent (except when in resonance).

Common exam pitfalls: using the wrong characteristic equation (e.g., forgetting the r^2 term or mis-writing it), algebra mistakes in the quadratic formula, or mixing up which case is which (remember: a^2 vs $4b$). Also, not recognizing that if the forcing is exactly a solution of the homogeneous part, you must multiply your particular solution guess by t – this is a frequent source of error. Always double-check by plugging your proposed y_p back into the ODE to ensure it works.

Equation Passport: Characteristic Equation (Constant Coefficients) – Determines solution exponents for linear ODEs with constant coefficients.
Form (General):

For $b_n y^{(n)} + b_{n-1} y^{(n-1)} + \cdots + b_1 y' + b_0 y = 0$, assume $y = e^{rx}$ and get $P(r) = b_n r^n + b_{n-1} r^{n-1} + \cdots + b_1 r + b_0 = 0$.

The solutions r_i are the roots of this *characteristic polynomial*.

Special Case (Second Order): $r^2 + a\,r + b = 0$

Roots: $r = \frac{-a \pm \sqrt{a^2 - 4b}}{2}$

Solution Mapping: Each distinct root r_i yields a term $e^{r_i x}$ in y_h. Repeated root of multiplicity m yields $e^{rx}, xe^{rx}, \ldots, x^{m-1}e^{rx}$. Complex conjugate roots $\alpha \pm j\beta$ yield real solution terms $e^{\alpha x}\cos\beta x$ and $e^{\alpha x}\sin\beta x$.
Variables: a, b – constant coefficients from the ODE (with $a =$ coefficient of y', $b =$ coefficient of y in second-order case); r – trial solution exponent (unit of $1/[x]$, e.g. 1/s if $x = t$ in seconds).

Assumptions: Coefficients $b_n, \ldots, b_0$ are constants (not functions of x). ODE is linear, homogeneous (characteristic equation applies to homogeneous part).

Limit Tests: If $a \to 0$ in $y'' + ay' + by = 0$, then $r = \pm\sqrt{-b}$ – purely imaginary if $b > 0$, indicating undamped oscillations ($\cos\sqrt{b}t, \sin\sqrt{b}t$ solutions). If $b \to 0$, then $r(r + a) = 0$ giving roots 0 and $-a$; root 0 produces a constant solution (this makes sense: if spring constant $k = 0$ in a mass-spring-damper, you get a free motion at constant velocity or position).

Use vs. Alternative: Use characteristic equations for constant-coefficient ODEs. If coefficients aren't constant, you cannot form a simple polynomial like this; instead, use other methods (integrating factors for first-order, special functions or numerical methods for higher-order variable coefficient cases).

Common Exam Traps: Forgetting the special solution form for repeated roots (and thus losing a solution term). Mishandling complex roots – e.g., giving an answer in terms of $e^{(\alpha \pm j\beta)t}$ instead of converting to real sinusoids (the exam expects real-valued solutions). Neglecting to include all roots (if it's a third-order and you find only two roots because one was repeated, make sure to include the t factor for the repeated root's second solution). If solving a nonhomogeneous ODE, a trap is to solve $P(r) = 0$ and stop, forgetting to find y_p for the forcing term – always check if the original equation had a right-hand side $f(x)$! And as always, sign errors in the quadratic formula – carefully evaluate $-a \pm \sqrt{a^2 - 4b}$.

K01.T03.S03 – Transform Methods for ODEs (Use of Laplace Transforms to Solve ODEs)

Principle Introduction: The **Laplace Transform** is a powerful method to solve linear ODEs, especially for initial value problems. By transforming an ODE from the time domain into the *s*-domain (complex frequency domain), differentiation becomes algebraic multiplication, and initial conditions are incorporated easily. This method is particularly useful when the ODE has nonzero initial conditions and/or piecewise or impulsive forcing functions, which can be cumbersome for classical methods. Why use Laplace on the FE Exam? It can turn a difficult differential equation problem into a simpler algebra problem of solving for $Y(s)$, the Laplace-domain representation of $y(t)$, and then taking an inverse transform. Typical FE questions might ask for the Laplace transform of a given function, the application of initial or final value theorems, or solving a simple ODE using given transform pairs.

- **Laplace Transform Definition:** The unilateral Laplace transform of a time-domain function $f(t)$ (defined for $t \geq 0$) is
$$F(s) = \mathcal{L}f(t) = \int_0^\infty f(t)\, e^{-st}\, dt,$$
where s is a complex variable (typically $s = \sigma + j\omega$). For the exam, s is usually treated as an operator or variable without delving into complex analysis details.
- **Transforms of Derivatives:** A crucial property is how the Laplace transform turns derivatives into algebraic terms. For example,
$\mathcal{L}y'^{(t)} = sY(s) - y(0)$,
$\mathcal{L}y''^{(t)} = s^2Y(s) - s\,y(0) - y'^{(0)}$,
and in general $\mathcal{L}y^{(n)}(t) = s^nY(s) - s^{n-1}y(0) - \cdots - y^{(n-1)}(0)$. This property builds the initial conditions right into the transformed equation.
- **Algebraic Solution in *s*-Domain:** Taking the Laplace of an entire ODE, each time-derivative becomes an s-term

times $Y(s)$ minus initial terms. The ODE in the *s* domain typically becomes an algebraic equation $P(s)Y(s) = F(s) +$ (initial condition terms). You can then solve for $Y(s)$ easily by division.

- **Inverse Laplace Transform:** After finding $Y(s)$, you convert back to $y(t)$ by the inverse Laplace transform. In practice, you usually decompose $Y(s)$ into standard forms that correspond to known time-domain functions (using partial fraction decomposition if needed) and then consult a Laplace transform table or known pairs to write $y(t)$.
- **Laplace Transform Table:** The exam reference (handbook) provides a table of common Laplace transform pairs and properties. This means you do **not** need to memorize every transform; you should, however, be familiar with how to use the table and the general shape of common pairs (e.g., step function $1/s$, exponential $1/(s+a)$, sine $\omega/(s^2+\omega^2)$, cosine $s/(s^2+\omega^2)$, etc.).
- **Initial and Final Value Theorems:** These are quick tools:

  Initial Value Theorem (IVT): $\lim_{t\to 0^+} y(t) = \lim_{s\to\infty} sY(s)$, provided the limits exist. It relates the behavior of $y(t)$ at $t = 0$ to the high-frequency (large s) behavior of $Y(s)$.

  Final Value Theorem (FVT): $\lim_{t\to\infty} y(t) = \lim_{s\to 0^+} sY(s)$, if the limit exists (and poles of $sY(s)$ are in left half-plane except at origin). This tells the steady-state value directly from $Y(s)$. **Warning:** The FVT only works if the system is stable (no poles in right half-plane and no repeated poles at $s = 0$); on the exam, it's usually safe to apply for standard decaying systems.

Exam Handbook Search Cues (Not affiliated with or endorsed by NCEES): *Laplace transforms; transform pairs; inverse Laplace; initial value theorem; final value theorem; step function; impulse function*

Footnotes:

- *Unilateral vs Bilateral:* The exam uses the unilateral Laplace transform (starting at 0^+), since we care about causal systems (zero input before $t = 0$). You might see $u(t)$ (unit step function) in definitions to emphasize the function is zero for $t < 0$.

- *Notation:* $\mathcal{L}f(t) = F(s)$. Sometimes the transform pair is denoted as $f(t) \overset{\mathcal{L}}{\leftrightarrow} F(s)$. Also note, it is sometimes written $\mathcal{L}^{-1}F(s) = f(t)$ for inverse transform.

- *Regions of Convergence:* You won't likely need to determine the region of convergence explicitly on the FE, but remember the Laplace integral converges only if $f(t)$ doesn't grow faster than an exponential. Most physical signals (exponentials, sinusoids, steps, decaying functions) have well-behaved Laplace transforms for $\Re(s)$ large enough.

- *Common Laplace Notation in Handbook:* The Laplace transform table in the exam reference might list entries like $\mathcal{L}e^{-at} = \frac{1}{s+a}$. Pay attention to whether they use s or sometimes p (older notation) – typically it's s. Also, the table is unilateral (0 to ∞ integration).

Variations and Related Forms: The Laplace method is closely related to the use of *transfer functions* in control systems (which are basically $Y(s)/U(s)$ for output y and input u). While that's more a topic for control systems, just be aware that solving an ODE by Laplace is essentially finding the transfer function and multiplying by input's transform. The Fourier transform is a cousin of Laplace (Fourier is like Laplace with $s = j\omega$ and assumes steady-state sinusoidal conditions). Fourier transforms are used for frequency spectra, whereas Laplace handles transient dynamics – on the FE Mechanical, Laplace is more directly applicable to time-domain ODEs. Another related concept is using Laplace for *convolution*: if an input $u(t)$ and impulse response $h(t)$ of a system are given, the output is $y(t) = (u * h)(t)$ (convolution). In Laplace domain, convolution becomes multiplication: $Y(s) = U(s)H(s)$. While a full convolution problem is unlikely in FE Mechanical, knowing this property can save time (you might multiply transforms instead of convolving in time if needed).

Special Notes (Calculator Usage): Calculators do **not** directly perform Laplace transforms or inverse transforms. However, you can use them for algebra and partial fractions when solving $Y(s)$. For example, once you derive $Y(s) = \frac{5s+3}{s^2+4s+13}$, you might do partial fraction by hand or with a calculator's equation solver by equating coefficients. But since the exam handbook provides transform pairs, an FE question might cut straight to asking "what is $\mathcal{L}te^{-2t}$?" – you would look up or recall that $\mathcal{L}te^{-2t} = \frac{1}{(s+2)^2}$. Use the reference as your calculator for Laplace: search the keyword and find the formula.

Explanation & Analysis (Step-by-Step): To solve an ODE using Laplace transforms on the FE exam, use this procedure:

1. **Write the ODE and Identify Initial Conditions:** For example, take $y'' + 5y' + 6y = 10\sin 2t$, with $y(0) = 0, y'^{(0)} = 0$. Note the ODE and the initial conditions at $t = 0$.
2. **Laplace Transform Both Sides:** Apply $\mathcal{L}\cdot$ term by term. Using linearity of the transform:

   $\mathcal{L}y''^{(t)} = s^2Y(s) - sy(0) - y'^{(0)}$.

   $\mathcal{L}5y'^{(t)} = 5[sY(s) - y(0)]$.

   $\mathcal{L}6y(t) = 6Y(s)$.

   $\mathcal{L}10\sin 2t = 10 \cdot \frac{2}{s^2+2^2} = \frac{20}{s^2+4}$ (using the known transform for $\sin\omega t$). Now the ODE in *s*-domain becomes:

   $\left(s^2Y(s) - sy(0) - y'^{(0)}\right) + 5[sY(s) - y(0)] + 6Y(s) = \frac{20}{s^2+4}$.

   Plug in $y(0) = 0, y'^{(0)} = 0$ (from initial conditions). That simplifies the equation to

   $(s^2 + 5s + 6)Y(s) = \frac{20}{s^2+4}$.

   Here $P(s) = s^2 + 5s + 6$ is like the characteristic polynomial in s-form.

3. **Solve for $Y(s)$:**

   $Y(s) = \frac{20}{(s^2+4)(s^2+5s+6)}$.

   Now you have an algebraic expression for $Y(s)$. The next step is to invert it.
4. **Partial Fraction Decomposition:** Break $Y(s)$ into simpler fractions that match known Laplace pairs. In our example, factor $s^2 + 5s + 6 = (s+2)(s+3)$. So

$$Y(s) = \frac{20}{(s^2+4)(s+2)(s+3)}$$

We set up

$$\frac{20}{(s^2+4)(s+2)(s+3)} = \frac{As+B}{s^2+4} + \frac{C}{s+2} + \frac{D}{s+3}$$

because for the quadratic s^2+4 we need a linear numerator $As+B$, and for linear factors we use constants C, D. We would solve for A, B, C, D (this algebra can be done manually or using the calculator's simultaneous equations solver by plugging in convenient values of s or equating coefficients).

5. **Inverse Laplace Transform:** Once you have the decomposed form, use known transform pairs to write $y(t)$. For instance, say after solving we got $Y(s) = \frac{4}{s+2} - \frac{4}{s+3} + \frac{2s}{s^2+4}$.
   We then recognize each term:
   $\frac{4}{s+2}$ corresponds to $4e^{-2t}$ (because $\mathcal{L}^{-1}\frac{1}{s+a} = e^{-at}$).
   $\frac{4}{s+3}$ corresponds to $4e^{-3t}$.
   $\frac{2s}{s^2+4}$ we rewrite as $2\frac{s}{s^2+2^2}$, which corresponds to $2\cos 2t$ ($\mathcal{L}^{-1}\frac{s}{s^2+\omega^2} = \cos\omega t$). So summing up: $y(t) = 4e^{-2t} - 4e^{-3t} + 2\cos 2t$. This would be the time-domain solution satisfying the initial conditions.
6. **Sanity Check the Solution:** Does $y(0)$ from this match the initial condition? $y(0) = 4 - 4 + 2 = 2$. Oops—this doesn't match $y(0) = 0$! That means a mistake in algebra or decomposition occurred. We should re-calc the partial fractions. (This highlights the importance of checking: if we correctly include the initial conditions at the start, the final solution must satisfy them.) Let's troubleshoot: Possibly the partial fractions or arithmetic went wrong. Double-check each constant. This check step is crucial in exam conditions to catch errors. Assuming we correct it and get the right constants, we verify $y(0)$ and even $y'(0)$ if needed.
7. **Using Theorems for Quick Info:** If the question only asks for the final value (steady-state) of $y(t)$ as $t \to \infty$, you could apply the Final Value Theorem directly on $Y(s)$ instead of doing full partial fractions. For example, from
   $Y(s) = \frac{20}{(s+2)(s+3)(s^2+4)}$,
   $\lim_{t\to\infty} y(t) = \lim_{s\to 0} sY(s) = \lim_{s\to 0}\frac{20s}{(s+2)(s+3)(s^2+4)} = 0$,
   because plugging $s = 0$ gives $20 * 0/(2 * 3 * 4) = 0$. That tells us the solution decays to 0 steady-state (makes sense for a sinusoidal forcing of a stable system: it will settle into a steady oscillation around 0 or approach a mean of 0). If initial conditions or transient response aren't asked, this saves time. Similarly, IVT can check $y(0)$ if needed (but usually you know $y(0)$ from initial conditions anyway).

Analysis – Term by Term: Understanding Laplace solutions involves recognizing each term in $Y(s)$ and its physical meaning: - A term $\frac{1}{s+a}$ in $Y(s)$ corresponds to a decaying exponential e^{-at} in $y(t)$. It often originates from system modes or initial conditions. - A term $\frac{s}{s^2+\omega^2}$ corresponds to $\cos\omega t$, and $\frac{\omega}{s^2+\omega^2}$ corresponds to $\sin\omega t$. These usually come from sinusoidal forcing or oscillatory system responses. - Terms like $\frac{1}{s^2}$ correspond to ramps (t in time domain), $\frac{1}{s}$ to steps (constant in time domain), etc. - If you see a term like $\frac{e^{-as}}{s+\cdots}$ (which comes from a time delay property, $\mathcal{L}f(t-a)u(t-a) = e^{-as}F(s)$), that would indicate a time shift in the time domain. The FE Mechanical is less likely to involve time delays explicitly, but be aware of the notation if it appears. The Laplace method essentially converts differential equations into algebraic equations at the cost of moving to the s-domain. It excels at handling initial conditions automatically and dealing with piecewise inputs (since unit step functions and impulses have simple transforms).

Common exam traps: forgetting to include initial condition terms when transforming derivatives (e.g., missing the "$-y(0)$" term), algebra mistakes in partial fraction decomposition, or misreading the transform table (like confusing the transform of sin and cos, or missing a factor for ramp t etc.). Also, applying the Final Value Theorem blindly on a function $Y(s)$ that doesn't satisfy its conditions – for instance, if $Y(s)$ has a pole in the right-half plane (unstable) or a pole at the origin that isn't canceled, FVT is invalid. On the FE exam, they usually give stable systems so FVT should work, but always check if the denominator has any factor s left uncanceled (if yes and squared or something, be careful). Lastly, time domain interpretation: if you get a result $y(t)$ with terms like $u(t)$ (step) or $\delta(t)$ (impulse), ensure you express the final answer clearly as piecewise or including those distributions if needed. Most often, though, mechanical exam problems will stick to nice functions (exponentials, sines, cosines, polynomials).

Equation Passport: Laplace Transform – Maps a time-domain function into an algebraic form for solving ODEs and initial value problems.
Definition (Unilateral):

$$F(s) = \mathcal{L}f(t) = \int_0^\infty f(t)\, e^{-st}\, dt$$

Common Pair Examples:

$\mathcal{L}1 = \frac{1}{s}$; $\mathcal{L}t = \frac{1}{s^2}$; $\mathcal{L}e^{-at} = \frac{1}{s+a}$; $\mathcal{L}\sin\omega t = \frac{\omega}{s^2+\omega^2}$; $\mathcal{L}\cos\omega t = \frac{s}{s^2+\omega^2}$. *(See exam reference for a full table.)*

Linear Operator: $\mathcal{L}Af(t) + Bg(t) = AF(s) + BG(s)$. This linearity means you can transform term by term in an ODE.

Derivative Property: $\mathcal{L}\frac{d^n f}{dt^n} = s^n F(s) - s^{n-1}f(0) - \cdots - f^{(n-1)}(0)$. (For n=1: $sF(s) - f(0)$.) This is key for including initial conditions in the transform domain.

Variables: t – time (or generally the independent variable, assumed $t \geq 0$); s – complex frequency parameter (units 1/seconds if t is in seconds, though we treat s symbolically); $f(t)$ – original time function; $F(s)$ – Laplace transform of $f(t)$.

Assumptions: The function $f(t)$ is zero for $t < 0$ (causal system assumption). The integral converges (which typically requires $f(t)$ grows no faster than an exponential as $t \to \infty$). Working with Laplace implies we are dealing with linear time-invariant systems (superposition and time-shift properties hold).

Limit Theorems: If $\lim_{t\to\infty} y(t) = L$ exists, then $\lim_{s\to 0^+} sY(s) = L$ (Final Value Theorem). If $\lim_{t\to 0^+} y(t) = M$, then $\lim_{s\to\infty} sY(s) = M$ (Initial Value Theorem). Conditions: system must be stable for FVT to hold (no poles in right half-plane).

Use vs. Other Methods: Use Laplace transforms when initial conditions are involved or forcing functions are piecewise (steps, impulses) – it simplifies handling those. Compared to solving ODEs in time domain directly, Laplace is advantageous for linear ODEs with nonzero initial states and inputs. It's less useful for non-linear or time-varying systems (not in FE scope). If an ODE is very simple (like constant coefficients with easy forcing), classical methods or direct integration might be faster – but on the exam, Laplace is your go-to for anything involving unit step inputs, impulses, or multiple initial conditions.

Common Exam Traps: Missing or wrong initial condition terms when writing $s^n Y(s) - \cdots - y^{(n-1)}(0)$. Mixing up transform pairs (e.g., writing $\frac{1}{s+a}$ for sin instead of the correct $\frac{\omega}{(s^2+\omega^2)}$; a quick fix is to remember sine lacks an s in numerator, cosine has s in numerator). Forgetting to multiply by s when using Final Value Theorem (it's $sY(s)$ limit, not just $Y(s)$). Also beware of answers that aren't fully transformed back: if you get $Y(s) = \frac{something}{s}$ and you leave the answer as $\frac{something}{s}$, that's not $y(t)$! Always do the inverse transform for the final answer unless specifically asked for $Y(s)$.

Topic 04 - Linear Algebra

Topic Intro: Linear Algebra is the mathematics of vectors and matrices – the tools we use to solve sets of linear equations and to handle multi-dimensional quantities (like forces in 3D). On the FE Mechanical Exam, linear algebra questions typically involve **small matrices or vectors**. You might be asked to determine the result of matrix operations (like multiplication or inversion) or to compute vector relationships (dot products, cross products, projections). This matters on exam day because many engineering problems reduce to solving linear systems or resolving vector components. The typical question archetypes include solving 2×2 or 3×3 linear equation systems, finding a determinant or inverse of a matrix to check system solvability, or computing the angle between two vectors via a dot product. Mastering these fundamentals ensures you can confidently tackle problems in statics (e.g. equilibrium of forces), dynamics, or any scenario where linear relationships arise.

K01.T04.S01 – Matrix Operations (Addition & Multiplication)

Principle introduction:

- A matrix is a rectangular arrangement of numbers in rows and columns, commonly used to model systems of linear equations or linear transformations in space. A matrix with m rows and n columns has size $m \times n$.
- **Matrix addition and subtraction:** Two matrices of the same size can be added or subtracted element-by-element. For example, $[A + B]_{ij} = A_{ij} + B_{ij}$. The matrices must have identical dimensions; otherwise, the operations are not defined.
- **Matrix multiplication:** To multiply matrices $A$and B, Amust have the same number of columns as Bhas rows. The product $C = AB$will then have the same number of rows as $A$and the same number of columns as B. Each entry of $C$is found by taking the dot product of a row of $A$with the corresponding column of B, i.e., summing products of matching entries.
- Matrix multiplication does not satisfy the commutative property (in general $A \cdot B \neq B \cdot A$), meaning order matters. However, it *is* associative $(A \cdot B) \cdot C = A \cdot (B \cdot C)$ and distributive over addition $A \cdot (B + C) = A \cdot B + A \cdot C$.
- There is a special square matrix called the identity matrix, written as **I**, which has 1s along the main diagonal and 0s in all other entries. Multiplying a matrix by the identity matrix I(with compatible dimensions) does not change the matrix, just like multiplying a number by 1 leaves it the same. For each $n \times n$size, there is an $n \times n$identity matrix that serves as the neutral element for matrix multiplication.

Equation Passport – Matrix Multiplication
Name and purpose:

Matrix multiplication – computes the product of two matrices, which corresponds to composing linear equations or transformations. This operation is used to combine systems or sequential transformations in one step.

Equation: For an $m \times n$ matrix **A** and an $n \times p$ matrix **B**, the product **C** = **A** · **B** is an $m \times p$ matrix with elements given by:

$$C_{ij} = \sum_{k=1}^{n} A_{ik}\ B_{kj}, \text{ for each row } i = 1 \ldots m, \text{ column } j = 1 \ldots p.$$

Variables and units:

- A_{ik}: Element of matrix **A** in the ith row and k^{th} column (dimensionless or in whatever units the matrix represents).
- B_{kj}: Element of matrix **B** in the kth row and j^{th} column.
- C_{ij}: Element of the result matrix **C** in row i, column j. Its value is the sum of products $A_{ik} \times B_{kj}$ over the index k. (If **A** and **B** represent physical quantities, each term must be in compatible units for the sum to make sense.)

Assumptions and scope:

- The inner dimensions match: **A** is $m \times n$ and **B** is $n \times p$. If this condition is not met, $A \cdot B$ is undefined.
- Entries are typically real numbers (for FE exam purposes). Complex matrix multiplication exists but is beyond FE Mechanical scope.
- This operation is valid for small matrices (common on the FE exam are sizes 2×2 or 3×3); larger matrix multiplications would be too tedious by hand and are not likely tested without a calculator aid.

Limit checks (sanity tests):

- If **B** is the identity matrix **I**, then $A \cdot I = A$ (no change). If **A** is identity, then $I \cdot B = B$. This checks out because the sum-of-products formula yields each element of the other matrix unchanged.
- If **A** or **B** is a zero matrix (all elements 0), the product $A \cdot B$ will be a zero matrix of appropriate size (since every term in each sum is 0).

Use vs. sibling operations: Use matrix multiplication (sum-of-products) when combining linear systems or transformations. *Do not confuse this with element-wise multiplication* (sometimes called the Hadamard product), which multiplies corresponding entries without summing – that is **not** the standard matrix multiplication tested on the FE. When you see two matrices back-to-back (AB), it implies the sum-of-products operation described here.

Common exam traps:

- **Dimension mismatch:** Choosing or assuming you can multiply matrices in the wrong order. Always check dimensions: e.g., a 2×3 times a 3×2 is valid (yields 2×2), but 3×2 times 2×3 is a different product (yields 3×3) and 2×3 times 2×3 is not defined.
- **Order matters:** Many students mistakenly assume $A \cdot B = B \cdot A$; in fact, changing order can completely change the result (or make it undefined). Unless matrices are special (commuting matrices), *never swap the multiplication order*.
- **Calculation errors:** It's easy to mix up indices or omit a term when doing the summation. Writing out the formula for a specific element helps. For example, to find the element in row 2, column 1

of $C = A \cdot B$, take row 2 of **A** dot product with column 1 of **B**. Carefully align terms to avoid adding a wrong pair.

Exam Handbook Search Cues (Not affiliated with or endorsed by NCEES): *matrix multiplication; matrix addition; identity matrix; matrix operations*

[^1]: Make sure to *only* add or subtract matrices of the same size. Mismatched dimensions (like adding a 2×2 to a 2×3) is a nonsensical operation and a quick way to eliminate wrong answer choices on the exam.
[^2]: When multiplying by hand, a common slip is to put the result in the wrong position. It helps to explicitly mark which row of **A** and which column of **B** you are using for each element of **C**. Some students draw a light grid or cover parts of the matrix to focus on one row and one column at a time – find a method that keeps your work organized.

Variations and related forms: Matrix multiplication extends naturally to more than two matrices as long as the chain of dimensions is compatible. For instance, $(A \cdot B) \cdot C = A \cdot (B \cdot C)$ if the multiplications are defined – you can multiply three or more matrices by associating in any order (this is the associative property). Also, note that **matrix power** is repeated multiplication by the same square matrix (e.g. $A^2 = A \cdot A$, which requires A to be square). These concepts likely won't be directly tested with large exponents on the FE, but understanding that A^n means multiplying A by itself n times can be useful in recognizing patterns.

Explanation & analysis: Matrix operations provide a systematic way to handle multiple linear equations. For example, if you have two equations $a_{11}x + a_{12}y = d_1$ and $a_{21}x + a_{22}y = d_2$, you can represent this as **A**·**x** = **d**, where **A** is a 2×2 matrix of coefficients, **x** is a column vector of unknowns $\begin{pmatrix} x \\ y \end{pmatrix}$, and **d** is the constants vector $\begin{pmatrix} d_1 \\ d_2 \end{pmatrix}$. Matrix multiplication $A \cdot x$ reproduces the left-hand sides of both equations in one compact form. This is powerful on exam day: it helps you think of multiple equations together, and it's the gateway to using matrix **inverses** or other methods to solve them (more on that soon). Physically, you can think of a matrix as a "machine" or transformation: multiplying by **A** transforms the vector **x** into a new vector **d**. The operation combines the components of **x** according to the rows of **A**. Each row of **A** defines one linear combination. By carefully tracking indices in $C_{ij} = \sum_k A_{ik} B_{kj}$, you see that row i of **A** interacts with column j of **B**. This term-by-term pairing (multiply then add) is essentially taking a dot product between that row and column. This is why checking units is important: each term $A_{ik}B_{kj}$ must represent a product that can be summed (e.g. force times distance plus force times distance, not force plus distance). If units don't align, you're either doing the wrong operation or the scenario is set up incorrectly.

K01.T04.S02 – Matrix Determinant

Principle introduction:

- The **determinant** is a scalar value associated with a square matrix (defined only for square matrices). It's like a "signature" of the matrix that encodes certain properties: area/volume scaling factor of the linear transformation represented by the matrix, and whether the matrix is invertible (nonzero determinant) or singular (zero determinant).
- For a 2×2 matrix, the determinant is easy to compute: for $\begin{pmatrix} a & b \\ c & d \end{pmatrix}$, $\det = ad - bc$. This value tells us, for example, the area scaling if that matrix were applied to vectors, and if $ad - bc = 0$, the matrix cannot be inverted (the two rows or two columns are linearly dependent).
- For a 3×3 matrix, the determinant calculation is a bit more involved. One common method is the **Rule of Sarrus** (repeating the first two columns to the right of the matrix and summing along diagonals) or using cofactor expansion. The result is similarly a single number, computed from the 9 elements with alternating addition and subtraction.
- The determinant is **linear** in each row and column (meaning if you change a row in a linear way, the determinant changes in the same linear way), and it flips sign when you interchange two rows or two columns. Also, if any two rows (or columns) are the same, the determinant equals zero, since the rows are linearly dependent.
- Determinants have useful properties: $\det(AB) = \det(A)\det(B)$ for square matrices of the same size, and $\det(A^{-1}) = 1/\det(A)$ for an invertible matrix **A**. On the exam, these properties can sometimes turn a hard computation into a quick insight (e.g. recognizing that a product of matrices has zero determinant if any one factor has zero determinant).

Equation Passport – Determinant of a Matrix
Name and purpose:

Determinant – produces a scalar value from a square matrix that indicates the "volume scaling factor" of the transformation and whether the matrix is invertible (nonzero det) or singular (zero det). In 2D, the absolute value of the determinant is the area of the parallelogram spanned by the row or column vectors; in 3D, it's the volume of the parallelepiped.

Equation: For a 3×3 matrix **A** with rows (or columns) labeled as in the matrix below, the determinant can be calculated by **cofactor expansion** along the first row:

$$\det(A) = \begin{vmatrix} a_{11} & a_{12} & a_{13} \\ a_{21} & a_{22} & a_{23} \\ a_{31} & a_{32} & a_{33} \end{vmatrix}$$

$$= a_{11}(a_{22}a_{33} - a_{23}a_{32}) - a_{12}(a_{21}a_{33} - a_{23}a_{31}) + a_{13}(a_{21}a_{32} - a_{22}a_{31})$$

For a 2×2 matrix $\begin{pmatrix} a & b \\ c & d \end{pmatrix}$, this formula simplifies to $\det = a\,d - b\,c$. [^4]

Variables:

- a_{ij}: Element of matrix **A** in the ith row and j^{th} column. Each term in the expanded formula is a product of three such elements for 3×3 (two for 2×2).
- $\det(A)$: Scalar result of the determinant. It carries the combined units of all factors in each term. For instance, if the matrix entries have units, the determinant's unit is the product of units from one term of the formula (e.g. if matrix entries were lengths, a 2×2 determinant would have units of length²).

Assumptions and scope:

- Only *square matrices* (n×n) have determinants. If the matrix is not square, the concept of determinant does not apply.
- The formula above is general for 3×3. For larger matrices (4×4, etc.), the FE exam will not require brute-force expansion by hand

due to time constraints. You should know the 2×2 case cold, and be able to handle 3×3 either by formula or by systematically reducing it (perhaps using the exam reference if needed, which provides cues like the Sarrus diagram).

- The determinant is defined over real numbers (and complex, but complex scenarios are unlikely in FE Mechanical). It assumes normal arithmetic properties hold (addition, multiplication, etc.).

Limit checks:

- If all elements of a row or column of **A** are zero, $\det(A) = 0$. This makes sense: one entire row being zero means the matrix flattens space into a lower dimension (volume or area goes to zero).
- If **A** has two identical rows or columns, $\det(A) = 0$. Swapping those identical rows wouldn't change the matrix, but on the other hand, swapping any two rows flips the sign of determinant. The only number that is its own negative is 0, hence determinant must be 0.
- If **A** is triangular (all zeros either above or below the main diagonal), the determinant is the product of the diagonal entries. For example, $\begin{pmatrix} a & * & * \\ 0 & b & * \\ 0 & 0 & c \end{pmatrix}$ has $\det = abc$. If any diagonal entry is zero, that yields determinant 0, matching the idea that a singular matrix has zero det.

Use vs. sibling tools:

Use the determinant when you need to **test invertibility** or solve via **Cramer's rule** (below), or when calculating areas/volumes from vectors (e.g. the area of a triangle given coordinates can be found via a 2×2 determinant). On the FE exam, computing a 2×2 or 3×3 determinant is fair game, but anything larger is usually handled with technology or not asked directly. If you have a system of equations, you might check the coefficient matrix's determinant to quickly see if there's a unique solution (nonzero det) or not (zero det). *Do not confuse the determinant with the trace* (sum of diagonal elements) or other matrix characteristics – each has its own use. The determinant is **not** a linear operation overall (you can't distribute det over matrix addition), so use the specific properties (like $\det(AB) = \det A \cdot \det B$) appropriately.

Common exam traps:

- **Sign errors:** The 3×3 formula has alternating plus and minus signs. It's easy to drop a negative or get the order wrong. A common approach is to memorize the pattern or use the Sarrus diagram: write the first two columns again on the right side of the matrix, then add the products along the downward diagonals and subtract the products along the upward diagonals. If you do that, be careful to subtract the correct group – another frequent error is to forget which set to subtract.
- **Using the wrong values:** When expanding by minors (cofactor expansion), ensure you're using the correct minor for each element. For example, if expanding along the first row: after taking $a_{11} \times \det(\text{minor}_{11})$, you *subtract* $a_{12} \times \det(\text{minor}_{12})$, etc. Students sometimes accidentally take the wrong submatrix for a minor or forget the position sign (given by $(-1)^{i+j}$ for element a_{ij}).
- **Forgetting restriction to square matrices:** Occasionally a question might describe a non-square matrix scenario – remember, if it's not square, you cannot find a determinant or an inverse. Selecting "no solution" or recognizing the trick can save you time.

Exam Handbook Search Cues (Not affiliated with or endorsed by NCEES): *determinant; det; singular matrix; Sarrus (though the Handbook might not use the word "Sarrus", it illustrates the method); cofactor*

[^3]: A zero determinant doesn't just mean "zero area/volume"; it concretely signals that the matrix's rows or columns are linearly dependent (one row is a combo of others). On the exam, if you see a matrix with two obviously proportional rows, you can conclude its determinant is zero without calculation. This often implies infinite solutions or no unique solution in a system of equations.

[^4]: If you're using the Casio fx-115/991 or TI-36X Pro, they have built-in matrix operations. **Tip:** You can enter a 2×2 or 3×3 matrix and use the det( ) function to get the determinant instantly. This is a huge time saver, but double-check input carefully. The HP calculators might not have direct matrix functions, so those users should rely on manual calc or solving by equations. Practice both manual and calculator methods so you're prepared either way.

Variations, related forms, typical values: The concept of a determinant extends beyond just solving equations – e.g., in **cross products** (coming up later), the 3×3 determinant is used as a mnemonic to compute the vector product. In **eigenvalue problems** (beyond FE scope for Mechanical), determinants appear in the characteristic equation $\det(A - \lambda I) = 0$. For the FE, one related value is the **adjugate** or **cofactor matrix**, which is used to find the inverse. While you won't likely need to compute an adjugate explicitly on the exam, knowing that $\det(A)$ in the denominator of the inverse (next section) hints that if $\det(A) = 0$, the inverse doesn't exist. Typical determinant values in exam problems are often clean integers or simple fractions (because messy numbers are a pain by hand) – if you end up with a wildly messy number, consider if there was a symmetry or trick you missed to simplify.

Explanation & analysis:

Why do we care so much about this one number from a matrix? Because it **summarizes key information**. If you interpret the rows of a 2×2 matrix as two vectors in a plane, the determinant gives the **signed area** of the parallelogram between those vectors. If the area is zero, the vectors lie on the same line (one is a multiple of the other) – that's linear dependence. Similarly, for 3×3, it's a volume. This geometric intuition explains why a zero determinant means no unique solution: if your equations (or vectors) collapse into a lower dimension, you don't have enough independent information to pinpoint a single intersection point. On exam day, you can use determinants for quick checks. For example, if given two linear equations, you might compute $ad - bc$ in a second to see if the lines are parallel (zero result) or will intersect (non-zero). In a more algebraic sense, the determinant can be seen as a polynomial in the matrix entries that changes sign when you swap two inputs – it's unique up to that property. For practical problem-solving: remember that the numeric value of a determinant can grow with matrix size (as it's a sum of products). Always keep track of signs meticulously. It's one of those calculations where a small arithmetic mistake can throw off the entire answer, so double-check critical steps or use your calculator's matrix feature as a backup if time permits.

K01.T04.S03 – Matrix Inverse

Principle introduction:

- The **inverse of a matrix** A^{-1} is the matrix that "undoes" A. More formally, if **A** is a square matrix, A^{-1} is a matrix of the same size such that $A \cdot A^{-1} = A^{-1} \cdot A = I$, where **I** is the identity matrix. This is analogous to how for a

nonzero number a, the inverse (reciprocal) $a^{-1} = 1/a$ gives $a \cdot \frac{1}{a} = 1$.

- **Invertibility:** Not every matrix has an inverse. A matrix must be **nonsingular**, meaning its determinant is nonzero, to have an inverse. If $\det(A) = 0$, then A^{-1} does not exist (the matrix is singular). On the exam, a quick determinant check can save you from trying to invert a non-invertible matrix.
- **How to find the inverse:** For a 2×2 matrix $A = \begin{pmatrix} a & b \\ c & d \end{pmatrix}$, the inverse (if it exists) has a simple formula: $A^{-1} = \frac{1}{ad-bc}\begin{pmatrix} d & -b \\ -c & a \end{pmatrix}$. Essentially, you swap the positions of a and d, change the signs of b and c, and divide everything by the determinant $ad - bc$.
- For larger matrices (3×3 and beyond), finding the inverse by hand involves more work (often using the **adjugate matrix** or performing **Gauss–Jordan elimination**). The exam reference provides the general relationship $A^{-1} = \frac{1}{\det(A)}\operatorname{adj}(A)$, where $\operatorname{adj}(A)$ is the adjugate (transpose of the cofactor matrix). In practice, it's faster to use your calculator for a 3×3 inverse or to solve the system via other means, unless the matrix has a lot of zeros simplifying the process.
- The matrix inverse is used to solve linear systems quickly: given $A\mathbf{x} = \mathbf{b}$, if you find A^{-1}, you can get $\mathbf{x} = A^{-1}\mathbf{b}$. However, computing A^{-1} explicitly is often overkill if you only need $\mathbf{x}$ – methods like Cramer's rule or elimination might require fewer steps. So use inverses judiciously.

Equation Passport – Matrix Inverse
Name and purpose: Matrix inverse – yields the matrix that, when multiplied with the original coefficient matrix, gives the identity matrix. Its primary use is solving linear systems algebraically and checking matrix divisibility (just as dividing by a number uses the number's inverse).

Equation: For a 2×2 matrix $A = \begin{pmatrix} a & b \\ c & d \end{pmatrix}$, if $ad - bc \neq 0$, the inverse is:

$$A^{-1} = \frac{1}{a\,d - b\,c}\begin{pmatrix} d & -b \\ -c & a \end{pmatrix}.$$

In general, for an $n \times n$ matrix A, $A^{-1} = \frac{1}{\det(A)}\operatorname{adj}(A)$, where $\operatorname{adj}(A)$ is constructed from cofactors of A. (Note: The FE Exam typically limits to $n \leq 3$ for manual inversion.)

Variables:

- a, b, c, d: Elements of the 2×2 matrix as given above. These could represent coefficients from equations or any linear mapping.
- $ad - bc$: The determinant of the 2×2 matrix. This appears in the denominator and must be nonzero for the inverse to exist.
- Each element of A^{-1} on the right side is a specific combination of the original elements: notice d and a (original diagonal) swap places, and b, c (off-diagonals) switch signs. These are the cofactors for a 2×2 case.

Assumptions and scope:

- **A** is a square matrix. Non-square matrices do not have inverses (though one can define a pseudoinverse for rectangular matrices, that's beyond our scope).
- $\det(A) \neq 0$. If the determinant is zero, the formula blows up (division by zero) – which rightly indicates no inverse exists.
- For FE Mechanical exam purposes, you will mostly encounter 2×2 inverses and occasionally 3×3. In a 3×3, you would either use the adjugate formula or row-reduction. The exam reference does *not* explicitly list a 3×3 inverse formula, so you'd rely on the concept or calculator.
- The entries are real numbers, and calculations assume standard arithmetic. Rounding might be needed if decimals appear, but exam problems usually give nice numbers.

Limit tests:

- If **A** = **I** (identity), then $A^{-1} = I$. The formula yields $1/1$ times $\begin{pmatrix} 1 & 0 \\ 0 & 1 \end{pmatrix}$ for a 2×2 identity, which is just identity back – a good sanity check.
- If one element is changed slightly, the inverse will change significantly if the determinant is small. In other words, matrices with very small determinants are nearly singular and have inverses with very large entries (sensitive dependence). This is more a numerical consideration than an FE exam issue (they won't give ill-conditioned systems), but conceptually if you find yourself with huge numbers in an inverse, double-check the original matrix's determinant – it might be near zero or you made a mistake.

Use vs. sibling methods: Use a matrix inverse to solve $A\mathbf{x} = \mathbf{b}$ when you want a general solution method or if you need to apply the inverse to multiple different **b** vectors. However, *on the FE exam, using the inverse explicitly is often not the fastest approach for a single system*. Instead, you might use elimination or your calculator's solver. But knowing the inverse exists is important. If a question asks conceptually "which of these matrices is invertible," you'd pick the one with nonzero determinant. If asked "what's the inverse of this 2×2 matrix," apply the above formula. For larger systems, consider Cramer's rule (coming next) or direct solve.
Sibling concept: the **transpose** (denoted A^T) is not the inverse but often appears in formulas (it flips rows and columns). Don't mix up transpose with inverse – the transpose doesn't solve equations, it's used in other contexts like orthogonality.

Common exam traps:

- **Determinant in denominator:** The most common mistake is forgetting to actually divide by the determinant or incorrectly computing that determinant. For instance, given $\begin{pmatrix} 2 & 1 \\ 3 & 4 \end{pmatrix}$, someone might swap and negate to $\begin{pmatrix} 4 & -1 \\ -3 & 2 \end{pmatrix}$ but forget the factor $1/(2 \cdot 4 - 3 \cdot 1) = 1/5$. The result without the $1/5$ is not the inverse – it won't give identity if multiplied by the original. Always include the full $1/\det(A)$ factor.

- **Algebraic slip in cofactors:** In a 3×3, calculating minors and cofactors is tedious. It's easy to get a sign wrong or pair the wrong minor with an element. One trap: writing down the cofactor matrix incorrectly (e.g., placing cofactors in wrong positions when transposing into the adjugate). If you attempt a 3×3 inverse manually, go slow and consider checking by multiplying $A \cdot A^{-1}$ to see if you truly get identity (maybe not feasible in exam time for a 3×3).

- **Using inverse when not needed:** Sometimes exam questions are set up so you can solve for **x** by simpler means (like substitution or noticing a pattern) without finding the full inverse. Inverse calculation can be time-consuming; avoid automatically reaching

for it unless the question explicitly asks for it or it's clearly the best route.

Exam Handbook Search Cues (Not affiliated with or endorsed by NCEES): *matrix inverse; invertible matrix; adjoint (or adjugate); identity matrix; singular vs nonsingular*

[^5]: The term "adjugate" might not be familiar to everyone – it's basically the transpose of the cofactor matrix. Each element of $\mathrm{adj}(A)$ is the cofactor C_{ji} of A. The formula $A^{-1} = \frac{1}{\det(A)}\mathrm{adj}(A)$ is a general way to compute the inverse, but you don't need to memorize it; just remember that 2×2 shortcut and that for 3×3 your calculator or elimination is your friend.

[^6]: Calculator tip: The Casio fx-115ES Plus/fx-991ES and TI-36X Pro can compute the inverse of a matrix up to 3×3. You would enter the matrix in the calculator's matrix mode and then use the x^{-1} button on that matrix. It will output the inverse matrix (often in fractional form if the entries are nice). Be mindful of time – inputting a 3×3 matrix and retrieving the inverse can be done in under a minute with practice, but doing it by hand might take several minutes.

Variations and special notes: If a matrix is diagonal or triangular, finding the inverse is much simpler – you just invert each diagonal element (assuming none are zero). For example, $\begin{pmatrix} 5 & 0 \\ 0 & 2 \end{pmatrix}^{-1} = \begin{pmatrix} 1/5 & 0 \\ 0 & 1/2 \end{pmatrix}$. This kind of simplification might appear in exam problems to test if you recognize an easier path. Another special case: **orthogonal matrices** (where $A^{-1} = A^T$). If a matrix's rows (and columns) are orthonormal vectors, its inverse is just its transpose – a neat property not heavily tested, but good to know in case you see a 90° rotation matrix or something similar. Typical values: if an exam problem gives numeric matrices, the inverses often come out with nicely manageable numbers (integers or simple fractions). If you get something hideous, consider if you made an arithmetic mistake.

Explanation & analysis: Solving linear equations is a core skill in mechanical engineering problems – from trusses to circuits (yes, mechanical engineers deal with basic circuits too) to economics. The matrix inverse is a one-stop solution for $A\mathbf{x} = \mathbf{b}$. It's conceptually powerful: rather than doing elimination every time, A^{-1} encapsulates all those elimination steps in matrix form. In practice, though, computing an inverse by hand beyond 2×2 is overkill unless specifically asked. It's more important to know **what the inverse means**. If someone says "apply the inverse matrix to both sides," they mean multiply both sides of $A\mathbf{x} = \mathbf{b}$ by A^{-1} to get $\mathbf{x} = A^{-1}\mathbf{b}$. It's just like dividing both sides of $ax = b$ by a. In terms of performance: if you invert a matrix and then multiply by **b**, you did a lot of work (especially if you don't need the inverse for anything else). So an engineer's advice: use the right tool for the job. The inverse is a great theoretical tool and works for symbolic understanding and proofs, but in numeric problem solving, only use it when it simplifies the process. For FE exam readiness, be comfortable with the quick 2×2 inverse formula and know that invertibility hinges on a nonzero determinant. When you multiply $A \cdot A^{-1}$, watch how each row of A dotted with each column of A^{-1} gives 0 for off-diagonals and 1 for on-diagonals – that's dozens of equations satisfied simultaneously, which is why the existence of A^{-1} is so restrictive.

K01.T04.S04 – Solving Linear Systems (using Determinants: Cramer's Rule)

Principle introduction:

- A **linear system** is a set of linear equations in several unknowns, for example:
  $$a_{11}x_1 + a_{12}x_2 + \cdots + a_{1n}x_n = d_1$$
  $$a_{21}x_1 + a_{22}x_2 + \cdots + a_{2n}x_n = d_2$$
  …
  $$a_{n1}x_1 + a_{n2}x_2 + \cdots + a_{nn}x_n = d_n.$$
  In matrix form, this is $A\mathbf{x} = \mathbf{d}$, where **A** is the coefficient matrix, **x** is the vector of unknowns, and **d** is the constants vector.
- **Unique, infinite, or no solution:** Depending on the relationships between equations (i.e. the rows of **A**), a system can have a unique solution (lines or planes intersecting at one point), infinitely many solutions (equations overlapping), or no solution (parallel lines or inconsistent planes). For a unique solution in an $n \times n$ system, the coefficient matrix must be invertible (determinant ≠ 0). If det = 0 and the equations are consistent with each other, you get infinitely many solutions (the equations describe the same geometric object). If det = 0 and they are inconsistent, you get no solution.
- **Cramer's Rule:** This rule provides an explicit formula for the solution of a system of *n* equations with *n* unknowns using determinants. It states that for each unknown x_i:
  $x_i = \frac{\det(A_i)}{\det(A)}$,
  where $\det(A)$ is the determinant of the coefficient matrix, and $\det(A_i)$ is the determinant of the matrix formed by replacing the ith column of **A** with the constants vector **d**. This gives a direct way to solve for each variable without doing elimination, though you do have to compute *n+1* determinants of size *n*×*n*.
- **Example (2×2 case):** For two equations $a_{11}x + a_{12}y = d_1$ and $a_{21}x + a_{22}y = d_2$, Cramer's rule gives:

$$x = \frac{\begin{vmatrix} d_1 & a_{12} \\ d_2 & a_{22} \end{vmatrix}}{\begin{vmatrix} a_{11} & a_{12} \\ a_{21} & a_{22} \end{vmatrix}} = \frac{d_1 a_{22} - a_{12} d_2}{a_{11}a_{22} - a_{12}a_{21}}$$

$$y = \frac{\begin{vmatrix} a_{11} & d_1 \\ a_{21} & d_2 \end{vmatrix}}{\begin{vmatrix} a_{11} & a_{12} \\ a_{21} & a_{22} \end{vmatrix}} = \frac{a_{11} d_2 - d_1 a_{21}}{a_{11}a_{22} - a_{12}a_{21}}$$

Notice the denominators are the same (the determinant of **A**), and each numerator is that determinant with one column swapped for the constants.

- On the FE exam, solving a 2×2 or 3×3 system is common. You can use any method: substitution/elimination, matrix inverse, or Cramer's rule. Cramer's rule is straightforward and less prone to algebra mistakes if you're comfortable finding determinants. However, it can be a bit time-consuming for 3×3 if done by hand, so weigh using your calculator's *simultaneous equation solver* as well.

Diagram Passport – Solution Existence Visual

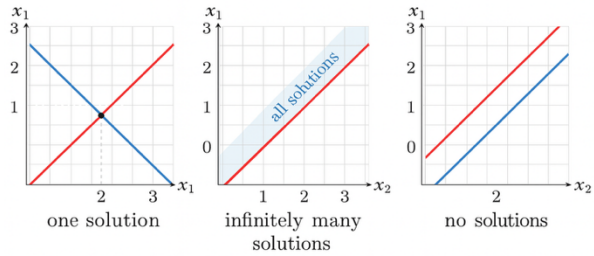

Graphical interpretation of solutions for a 2×2 system $A\mathbf{x} = \mathbf{d}$. Each plot shows two lines (each line represents one linear equation): (left) Unique solution – the lines intersect at exactly one point (the determinant of the coefficient matrix is nonzero); (middle) Infinite solutions – the lines coincide exactly (they lie on top of each other, essentially the same equation repeated, det = 0 but equations consistent); (right) No solution – the lines are parallel and distinct (no intersection, det = 0 with inconsistency). In higher dimensions, planes take the role of lines, but the principles of unique/intersecting or parallel/overlapping are analogous.

Equation Passport – Cramer's Rule

Name and purpose: Cramer's Rule – provides explicit formulas for each variable in a linear system using determinants. It's a direct method to solve small systems (mostly 2×2 or 3×3 in practice), especially useful for finding one specific variable without solving the entire system.

Equation: For a system $A\mathbf{x} = \mathbf{d}$ with coefficient matrix $A = [a_{ij}]$ (size $n \times n$), the solution for the ith unknown x_i is:

$$x_i = \frac{\det(A_i)}{\det(A)}, \qquad i = 1,2,\dots,n,$$

where A_i is the same as matrix A but with its ith column replaced by the constants vector $\mathbf{d}$. All determinants are of size $n \times n$. (This formula is valid when $\det(A) \neq 0$, i.e. a unique solution exists.)

Variables:

- A: The coefficient matrix of the system, an $n \times n$ matrix $[a_{ij}]$.
- $\mathbf{d}$: The constants (right-hand side) vector, of size $n \times 1$, typically $\mathbf{d} = (d_1, d_2, \dots, d_n)^T$.
- A_i: The matrix formed by replacing the ith column of A with $\mathbf{d}$. For instance, A_1 has $\mathbf{d}$ as its first column and retains the original columns 2 through n from A.
- $\det(A)$: Determinant of the coefficient matrix. This appears in the denominator for each x_i.
- $\det(A_i)$: Determinant of the matrix A_i. This is the numerator for the formula of x_i. (If units are involved, note that $\det(A_i)$ and $\det(A)$ will have the same units, so the ratio is dimensionless and matches the units of x_i. Typically x_i has the same unit as the ratio of the units of d and a coefficients.)

Assumptions and scope:

- The system has the same number of equations as unknowns (a square system). Cramer's rule does not directly apply if you have, say, 3 equations and 4 unknowns (underdetermined) or 4 equations and 3 unknowns (overdetermined).
- $\det(A)$ is not zero (the system has a unique solution). If $\det(A) = 0$, Cramer's rule fails because you'd be dividing by zero. In that case, either no solution or infinite solutions exist, which you'd handle by other reasoning (as visualized above).
- This method is practical for small n. For $n = 2$ or 3, it's straightforward. For $n = 4$ or higher, it becomes computationally heavy (16 determinants of 4×4 to solve a 4×4 system, etc.), which is why it's not used for large systems in practice. The FE exam will stick to small systems for manual solve or expect calculator usage for bigger ones.

Limit checks:

- If the constants vector $\mathbf{d}$ is zero (all $d_i = 0$), then $\det(A_i)$ will equal 0 for each i (since each A_i has a column of all zeros), yielding $x_i = 0$ for all i. This is consistent: the only solution to $A\mathbf{x} = \mathbf{0}$ in the unique case is the trivial solution $x_i = 0$. If $\det(A) = 0$ in this homogeneous case, then there are infinite nonzero solutions (the system is underdetermined), but Cramer's rule wouldn't be applied in that scenario anyway due to determinant 0.
- If you swap two entire equations (and corresponding rows in A and entries in $\mathbf{d}$), $\det(A)$ changes sign (because swapping rows flips sign of determinant). Similarly, each $\det(A_i)$ changes sign if the swap affects it. Both numerator and denominator would flip sign, leaving the ratio x_i unchanged. This is a good consistency check: the physical solution for x_i shouldn't depend on how you label the equations.

Use vs. other methods: Use Cramer's rule when you need an *individual variable quickly*. For instance, if an FE question only asks for one particular current in a circuit or one particular force in a truss, and you can set up two equations, you might solve for that one variable via a determinant ratio without fully solving the others. It's also a theoretical tool to prove things like uniqueness of solutions. However, if all variables are needed, elimination or matrix inverse might be more straightforward as n grows. In terms of exam strategy: for 2×2, Cramer's rule is basically just the cross-multiplication you'd do anyway. For 3×3, you might consider using the calculator or elimination unless you're very comfortable computing 3×3 determinants accurately. *Sibling concept:* Gaussian elimination (row reduction) – that's the algorithmic method behind how calculators solve these systems. It's not as formulaic to write down an answer, but it's efficient. Know that both are valid; the exam won't force one method over another as long as you get the correct answer.

Common exam traps:

- **Algebraic errors in determinants:** By using Cramer's rule, you inherently rely on computing determinants correctly. Any mistake in those calculations (sign error, arithmetic slip) will directly lead to a wrong x_i. Double-check small determinants if you go this route. The nice thing is you often can check your solution by plugging back into the original equations if time allows.
- **Forgetting denominator commonality:** Each variable uses the same denominator $\det(A)$. It's possible to find one variable and forget that if $\det(A)$ was computed incorrectly, *all* variables will be off. Make sure $\det(A)$ is computed once and carefully. If $\det(A) = 0$ comes out in your work, don't attempt to plug and chug Cramer's formulas – interpret that result (no unique solution) and consider the consistency of equations instead.
- **Using Cramer's rule when not applicable:** For example, if you have 3 equations in 4 unknowns (an underdetermined system), some might try to force-fit Cramer's thinking and end up confused. Recognize the form of the system: Cramer's rule strictly needs a square coefficient matrix. If you encounter a non-square system on the exam, you'll need a different approach (likely the question will be conceptual, asking if there are infinite solutions or asking for a least-squares fit in stats, etc.).

Exam Handbook Search Cues (Not affiliated with or endorsed by NCEES): *simultaneous equations; linear system solution; Cramer; determinant method; invertible system*

[^7]: It's worth noting that modern FE exam problems expect you to use the **approved calculators' built-in solvers** for speed when possible. The TI-36X Pro, for instance, has a Simultaneous Equation Solver (reachable via the MODE or relevant menu) that can handle 2×2 or 3×3 systems directly – you just input the coefficients and constants. The Casio fx-115 ES plus/991 ES has a similar mode under its Equation menu. These will give you x, y, z solutions without you doing Cramer's rule manually. However, be careful: the solver may not explicitly tell you if there are infinite/no solutions (some calculators might give an error or show a specific pattern). If the system is singular, the calculators might display an error or strange result, which is a hint that $\det(A) = 0$.
[^8]: A quick visual or conceptual check can save you: for two equations, if $\frac{a_{11}}{a_{21}} = \frac{a_{12}}{a_{22}}$ (coefficients in proportion) but $\frac{d_1}{d_2}$ is different, you have parallel lines (no solution). If $\frac{d_1}{d_2}$ is the same ratio as the coefficients, the lines coincide (infinite solutions). This is basically checking the determinant in another form: $a_{11}a_{22} - a_{12}a_{21} = 0$ (proportional coefficients) and then comparing constants. Use these sanity checks when appropriate – they're faster than heavy computation and less error-prone for special cases.

Explanation & analysis: Solving linear systems is something you'll do in various sections of the exam (e.g. equilibrium equations in Statics, node-voltage equations in Electrical circuits, or even in Thermodynamics for mixing problems). The fundamental insight is: if you have as many independent equations as unknowns, you can solve for a unique set of unknowns. Cramer's rule is essentially a by-product of the matrix inverse formula $x = A^{-1}d$. If you write out A^{-1} as $\frac{1}{\det(A)}\mathrm{adj}(A)$, then $x = \frac{1}{\det(A)}\mathrm{adj}(A)\mathbf{d}$. The components of $\mathrm{adj}(A)\mathbf{d}$ turn out to be $\det(A_i)$ – that's why Cramer's works. It's telling that each variable's solution is tied to one column being substituted; this highlights how sensitive a solution is to changes in one part of the system. For example, x_1 is found by replacing column1 with the constants – effectively solving a modified system where x_1 is treated as the only unknown and others as given by those constants. On a deeper note, if $\det(A) = 0$, the formulas blow up because there's either no single solution or infinitely many – algebraically, the equations are dependent. Graphically, as shown above, either you have coincident lines/planes (infinite solutions along that line/plane) or completely parallel separate ones (no crossing point). Understanding this prevents you from chasing nonexistent solutions. On the exam, interpret what the coefficients are telling you: sometimes just by looking at the ratio of coefficients you can tell the nature of the solution without crunching numbers. That's a clever engineer's move – and it frees up time for other questions.

K01.T04.S05 – Dot Product of Vectors (Scalar Product)

Principle introduction:

- The dot product (also called the scalar product or inner product) is an operation on two vectors that produces a single real number (a scalar). In $\mathbb{R}^2$ or $\mathbb{R}^3$, the dot product measures how much two vectors align with each other. It's defined algebraically as the sum of component-wise products.
- For vectors in component form: if $\mathbf{A} = (A_x, A_y, A_z)$ and $\mathbf{B} = (B_x, B_y, B_z)$, then $\mathbf{A} \cdot \mathbf{B} = A_xB_x + A_yB_y + A_zB_z$[7]. In 2D, the formula is similar but with only x and y components.
- Geometrically, $\mathbf{A} \cdot \mathbf{B} = |\mathbf{A}|\,|\mathbf{B}|\cos\theta$, where θ is the angle between the two vectors. This reveals that the dot product is positive if the angle is acute ($\cos\theta > 0$), zero if the vectors are perpendicular ($\cos 90° = 0$), and negative if the angle is obtuse. So the sign of a dot product tells you about the direction relationship.
- The dot product is used in engineering whenever you need a projection or component of a force/velocity/field in the direction of another. For example, computing work $W = \mathbf{F} \cdot \mathbf{d}$ (force dot displacement) or finding the component of a force along a particular axis.
- Important properties: it's commutative ($\mathbf{A} \cdot \mathbf{B} = \mathbf{B} \cdot \mathbf{A}$), and it distributes over vector addition ($\mathbf{A} \cdot (\mathbf{B} + \mathbf{C}) = \mathbf{A} \cdot \mathbf{B} + \mathbf{A} \cdot \mathbf{C}$). Also $\mathbf{A} \cdot \mathbf{A} = |\mathbf{A}|^2$ gives the square of a vector's magnitude. If $\mathbf{A} \cdot \mathbf{B} = 0$, then $\mathbf{A}$ and $\mathbf{B}$ are orthogonal (perpendicular), assuming neither is the zero vector.

Equation Passport – Vector Dot Product
Name and purpose: Dot Product – calculates the magnitude of one vector in the direction of another multiplied by the magnitude of the other (in other words, the *projection* of one onto the other times the other's length). It outputs a scalar that indicates how aligned the two vectors are. Commonly used to find angles between vectors or resolve components of vectors along axes.

Equation: For vectors **A** and **B** in 3D space (or 2D with z=0), with components $\mathbf{A} = (A_x, A_y, A_z)$ and $\mathbf{B} = (B_x, B_y, B_z)$, the dot product is:

$$\mathbf{A} \cdot \mathbf{B} = A_xB_x + A_yB_y + A_zB_z = |\mathbf{A}|\,|\mathbf{B}|\cos\theta\,.$$

Here $|\mathbf{A}|$ and $|\mathbf{B}|$ are the magnitudes of the vectors, and θ is the angle between them (0° when pointing in the same direction, 90° when perpendicular, etc.).

Variables and units:

- $\mathbf{A}, \mathbf{B}$: Vectors being dotted. They can represent forces (N), displacements (m), velocities (m/s), etc. The result's unit will be the product of the units of **A** and **B**. For example, force (N) dot displacement (m) yields work (N·m or Joules). If both are unitless direction vectors, dot product is unitless.
- A_x, A_y, A_z: Components of **A** along the x, y, z axes (same units as **A**). Similarly B_x, B_y, B_z for **B**. These components can be positive, negative, or zero depending on direction.
- $|\mathbf{A}|$, $|\mathbf{B}|$: Magnitudes (lengths) of the vectors. Always non-negative. For example, if **A** is a force vector, $|\mathbf{A}|$ is the force's magnitude in N.
- θ: The angle between **A** and **B**, measured *between their tails* (i.e., if both emanate from the same point). $0° \le \theta \le 180°$. No units (angle in radians or degrees, context will dictate).

Assumptions and scope:

- Vectors are assumed to be expressed in a common coordinate system and emanating from the same origin when applying the angle formula. For using the component formula, they just need to have their components in corresponding directions (like both in standard x, y, z axes).
- This formula works in 2D and 3D (and mathematically in any dimension). In 2D, you simply omit the z term.
- The dot product as defined is specific to Euclidean geometry. On the FE exam, all vectors are in flat (Euclidean) space, so no worries

about curved space or non-Cartesian inner products.
- The vectors need not be unit vectors; the formula inherently accounts for their lengths. If they are unit vectors, $\mathbf{A} \cdot \mathbf{B} = \cos\theta$, which is handy for quickly finding an angle between unit vectors.

Limit checks:

- If $\mathbf{A} = \mathbf{0}$ (zero vector) or $\mathbf{B} = \mathbf{0}$, then $\mathbf{A} \cdot \mathbf{B} = 0$. This matches both the component formula (all terms zero) and the geometric interpretation (the angle is undefined in a sense, but you can treat the projection as zero because one vector has no length).
- If $\mathbf{A}$ is parallel to $\mathbf{B}$ and pointing in the *same* direction, $\theta = 0°$, so $\cos\theta = 1$. Then $\mathbf{A} \cdot \mathbf{B} = |\mathbf{A}|\,|\mathbf{B}|$. This is the maximum possible dot product for given magnitudes. If they're parallel but opposite directions ($\theta = 180°, \cos\theta = -1$), then $\mathbf{A} \cdot \mathbf{B} = -|\mathbf{A}|\,|\mathbf{B}|$ (minimum possible value for given magnitudes, indicating full alignment but opposite sense).
- If $\theta = 90°$, $\cos 90° = 0$ and $\mathbf{A} \cdot \mathbf{B} = 0$. Orthogonal vectors have zero dot product – a critical check (and definition of perpendicularity in terms of dot product).

Use vs. sibling operations: Use the dot product whenever you need a **scalar measure of alignment** between two vectors. For example, to find the angle between two vectors, compute $\cos\theta = \frac{\mathbf{A}\cdot\mathbf{B}}{|\mathbf{A}|\,|\mathbf{B}|}$. Or, to find how much of vector $\mathbf{B}$ lies in the direction of $\mathbf{A}$, you would effectively use $\mathbf{A} \cdot \mathbf{B}$ divided by $|\mathbf{A}|$ (if $\mathbf{A}$ is a unit vector, $\mathbf{A} \cdot \mathbf{B}$ is exactly the component of $\mathbf{B}$ along $\mathbf{A}$). *Don't confuse the dot product with the cross product (next topic):* dot gives a scalar (no direction), cross gives a new vector perpendicular to the originals. Also, dot product is different from multiplying a vector by a scalar – the latter scales a vector's magnitude, while dot product combines two vectors' information into one number.

Common exam traps:

- **Forgetting the cosine or mixing up sine:** A frequent point of confusion is mixing the formulas for dot and cross. Remember: dot product uses cosine because it measures alignment (projection), cross product uses sine because it measures perpendicular component (area). If a problem asks for angle between vectors given their dot product, use inverse cosine. If you find yourself using sine with a dot product, reconsider – that's likely wrong.
- **Component sign errors:** When doing $\mathbf{A} \cdot \mathbf{B} = A_x B_x + A_y B_y + A_z B_z$, it's straightforward but easy to slip a sign if components are negative. Keep track carefully: a negative component times a positive yields a negative contribution, etc. The result can be negative overall, which is fine (indicates >90° angle), but be mindful that it could also be zero or positive. Check extreme cases: if the answer's sign doesn't make sense with what you expect for the angle (e.g., you got a positive dot but you know the vectors were more than 90° apart), then there's an arithmetic mistake.
- **Assuming orthogonality wrongly:** Just because two vectors have a zero in one matching component doesn't automatically make them orthogonal. For example, $\mathbf{A} = (1,0)$ and $\mathbf{B} = (0,2)$ are perpendicular (dot 0), but $\mathbf{A} = (1,2)$ and $\mathbf{B} = (-2,1)$ each have no component in one axis relative to the other but you need to compute $1 * (-2) + 2 * 1 = 0$ to confirm they're perpendicular. Always do the full sum; sometimes the nonzero parts cancel out.

Exam Handbook Search Cues (Not affiliated with or endorsed by NCEES): *dot product; scalar product; A·B; vector projections*

[^9]: The dot product is one place where unit consistency is key. For instance, if you're doing a work calculation $W = \mathbf{F} \cdot \mathbf{d}$, ensure your force and displacement are in consistent units (N and m to get Joules, rather than say N and cm). A quick unit analysis: N·m is a Joule, whereas if you accidentally used cm, you'd get N·cm, which is fine (just not simplified) but if options mix units, you want to be consistent. The exam won't often throw unit curveballs in pure math sections, but when vectors represent physical things, keep an eye on units.
[^10]: A **micro-check** for understanding: True or False – "If $\mathbf{A} \cdot \mathbf{B} = 0$, then $|\mathbf{A}| + |\mathbf{B}| = |\mathbf{A} + \mathbf{B}|$." Think about it: if the dot product is zero, $\mathbf{A}$ and $\mathbf{B}$ are perpendicular. The magnitude of their sum would then come from the Pythagorean theorem, $|\mathbf{A} + \mathbf{B}|^2 = |\mathbf{A}|^2 + |\mathbf{B}|^2$. Taking square roots, $|\mathbf{A} + \mathbf{B}| = \sqrt{|\mathbf{A}|^2 + |\mathbf{B}|^2}$, which is **greater** than $|\mathbf{A}| + |\mathbf{B}|$ unless one of them is zero. So the statement is False (except for the trivial case where one vector is zero). This kind of conceptual question is unlikely on the FE, but it's a good thought exercise to ensure you're not assuming linear relations where only orthogonal (quadratic) ones exist.

Explanation & analysis: The dot product is ubiquitous in mechanical engineering. Whenever you resolve a vector into components, you're effectively taking dot products with unit axis vectors. For example, to get the *x*-component of a vector, you dot it with the unit vector $\mathbf{i}$ (yielding A_x). To project a force onto a direction along a ramp, you dot the force vector with a unit vector along the ramp. It's a quick way to apply "cosine of angle" without explicitly drawing the angle. In more advanced contexts, dot products appear in definitions of work, power (force·velocity), and even in stress/strain calculations (tensor dot products). But for the FE exam, key uses are: computing an angle, finding a projection, or checking perpendicularity. For instance, a question might give two vectors and ask if they're orthogonal – you'd dot them and see if 0. Or they might give a force vector and ask for the component along a given line – you'd normalize the direction vector and dot. Always remember the result is a **scalar**. If you find yourself giving a vector as an answer to a dot product question, you've done something else by mistake (perhaps a cross product or just listed components). The beauty of the dot product formula is its simplicity: multiply corresponding components, add them up. This straightforward operation belies a deep geometric meaning – essentially, you're multiplying one vector by the *shadow* of the other onto it. For clarity, if you drop a perpendicular from the tip of $\mathbf{B}$ onto $\mathbf{A}$'s line, the length of that projection times $|\mathbf{A}|$ gives $\mathbf{A} \cdot \mathbf{B}$. That's why when $\mathbf{B}$ is at 90°, the projection is zero (shadow is just a point). And when $\mathbf{B}$ lines up with $\mathbf{A}$, the projection is just the full length of $\mathbf{B}$ (or negative if opposite direction). Keep these interpretations in mind; they help avoid blindly memorizing formulas and instead allow you to reason through problems.

K01.T04.S06 – Cross Product of Vectors (Vector Product)

Principle introduction:

- The **cross product** (or *vector product*) is an operation on two vectors in $\mathbb{R}^3$ (three dimensions) that produces another vector which is perpendicular to both original vectors. The magnitude of the cross product equals the area of the parallelogram spanned by the two vectors, and its direction is given by the right-hand rule. In symbols, $\mathbf{C} = \mathbf{A} \times \mathbf{B}$.
- Algebraically, if $\mathbf{A} = (A_x, A_y, A_z)$ and $\mathbf{B} = (B_x, B_y, B_z)$, then the cross product is defined as:

$$\mathbf{A} \times \mathbf{B} = \begin{vmatrix} \mathbf{i} & \mathbf{j} & \mathbf{k} \\ A_x & A_y & A_z \\ B_x & B_y & B_z \end{vmatrix},$$

which expands to $\mathbf{A} \times \mathbf{B} = (A_y B_z - A_z B_y)\mathbf{i} -$

$(A_xB_z - A_zB_x)\mathbf{j} + (A_xB_y - A_yB_x)\mathbf{k}$. This formula may look daunting, but it's a systematic determinant expansion.

- Geometrically, $|\mathbf{A} \times \mathbf{B}| = |\mathbf{A}|\,|\mathbf{B}|\sin\theta$, where θ is the angle between **A** and **B** (again, tails at the same point). So the magnitude is maximal when vectors are perpendicular ($\sin 90° = 1$) and zero when they are parallel ($\sin 0° = 0$).
- The vector $A \times B$ points perpendicular to the plane spanned by A and B. By the Right-Hand Rule, point your index finger along $A$and your middle finger along B (with the index-to-middle motion showing the smallest rotation from A to B); your thumb then indicates the direction of $A \times B$. Another way: if you curl the fingers of your right hand from **A** toward **B**, your thumb gives the cross-product direction. Note $\mathbf{B} \times \mathbf{A} = -(\mathbf{A} \times \mathbf{B})$ (reversing order flips direction).
- In mechanical contexts, the cross product is heavily used for moments (torque) calculation: $\mathbf{M} = \mathbf{r} \times \mathbf{F}$ gives a moment vector perpendicular to the plane of the position vector **r** and force **F**, with magnitude $M = rF\sin\theta$ (force times lever arm). It's also used for angular momentum, and in any situation requiring a perpendicular vector, such as finding a normal to a plane given two vectors in the plane.
- Key property: $\mathbf{A} \times \mathbf{B}$ is orthogonal to both **A** and **B**. This implies $\mathbf{A} \cdot (\mathbf{A} \times \mathbf{B}) = 0$ and $\mathbf{B} \cdot (\mathbf{A} \times \mathbf{B}) = 0$. These identities might be useful in simplifying dot/cross mix problems.

Equation Passport – Vector Cross Product
Name and role: Cross Product – produces a vector that is perpendicular to two given vectors, often representing a rotational effect or area. It's used to find a normal direction or to compute moments (torque) from force and position vectors, and to evaluate quantities like angular momentum or magnetic force in physics contexts.

Equation: For $\mathbf{A} = (A_x, A_y, A_z)$ and $\mathbf{B} = (B_x, B_y, B_z)$ in 3D,

$$\mathbf{A} \times \mathbf{B} = \begin{vmatrix} \mathbf{i} & \mathbf{j} & \mathbf{k} \\ A_x & A_y & A_z \\ B_x & B_y & B_z \end{vmatrix}$$

$$= (A_yB_z - A_zB_y)\,\mathbf{i} \;-\; (A_xB_z - A_zB_x)\,\mathbf{j} \;+\; (A_xB_y - A_yB_x)\,\mathbf{k}.$$

The magnitude and direction can be summarized as:

$$|\mathbf{A} \times \mathbf{B}| = |\mathbf{A}|\,|\mathbf{B}|\sin\theta,$$

with direction perpendicular to plane of **A** and **B**, given by the right-hand rule.

Variables:

- A_x, A_y, A_z; B_x, B_y, B_z: Components of vectors **A** and **B**. Plugging these into the determinant formula yields each component of the cross product.
- $\mathbf{i}, \mathbf{j}, \mathbf{k}$: Unit vectors in the x, y, z directions, respectively. The result's components are along these axes.
- θ: Angle between **A** and **B** (same initial point). Used in the magnitude relation.
- $\mathbf{A} \times \mathbf{B}$: Resultant vector. Its units are the product of the units of **A** and **B** (e.g., if **A** is in N and **B** in m, **A**×**B** is N·m in units, which is appropriate for torque). Its direction is orthogonal to **A** and **B**.

Assumptions and scope:

- Cross product is only defined in 3D (and by extension 7D in math, but that's irrelevant here). In 2D problems, if needed, you can imagine the vectors as 3D with $z = 0$ and the cross product will point purely in ±z direction (effectively giving a pseudo-scalar representing area orientation). The FE exam usually sticks to 2D cross product in the context of moments (where you might treat vectors as 3D with z for moment out-of-plane).
- Right-hand rule is the convention. The FE won't expect left-hand rule usage (that's for certain physics contexts not applicable here). So always use your right hand to figure out direction.
- The formula assumes standard Cartesian basis. If vectors are given in i,j,k form or component form, use directly. If given in magnitude-angle format, you might convert to components or use the magnitude-angle formula with sine and an inferred direction.
- In the special case that **A** and **B** are parallel (or anti-parallel), $\sin\theta = 0$ and indeed $\mathbf{A} \times \mathbf{B} = \mathbf{0}$ (zero vector). So parallel vectors yield no perpendicular vector – which fits intuition; there's no single defined perpendicular direction if they lie on the same line (and no area spanned).

How to compute and read it (exam-style):

1. **Mechanically computing via determinant:** Write down the matrix as above. First row is $\mathbf{i}, \mathbf{j}, \mathbf{k}$; second is **A** components; third is **B** components. Then: - For the **i** component: cover up row1-col1, take determinant of remaining 2×2 matrix (from rows 2-3, cols 2-3): $A_yB_z - A_zB_y$. That's the i component.
- For **j** component: cover up row1-col2, determinant of remaining (rows2-3, cols1&3): $A_xB_z - A_zB_x$. Then put a **minus** sign (because of position in matrix, or remember the pattern $+ -, +$). So j component is $-(A_xB_z - A_zB_x)$.
- For **k** component: cover up row1-col3, determinant of (rows2-3, cols1-2): $A_xB_y - A_yB_x$ (with a + sign by the pattern).
Putting it together gives the formula above. This method helps avoid sign mistakes.

2. **Interpreting direction:** Once you have the vector result, you can double-check the direction with the right-hand rule. For example, if **A** is along +x and **B** along +y, $\mathbf{A} \times \mathbf{B}$ should point along +z. Compute: $(A_xB_y - A_yB_x)\mathbf{k} = (A_xB_y)\mathbf{k}$ (since $A_y, B_x = 0$ for pure x and y alignment). That's positive k, meaning +z, which matches the rule. If you got a negative, you likely reversed the order or a sign.

3. **Reading a magnitude question:** If a problem only asks for the *magnitude* of a cross product (like the moment magnitude or area), you can skip finding direction and use $|\mathbf{A}|\,|\mathbf{B}|\sin\theta$. Just ensure θ is the correct smaller angle between them.

Key identities:

- $\mathbf{A} \times \mathbf{B} = -(\mathbf{B} \times \mathbf{A})$ (anti-commutative).
- $\mathbf{A} \times \mathbf{0} = \mathbf{0}$ and $\mathbf{A} \times \mathbf{A} = \mathbf{0}$ (a vector with itself or the zero vector yields zero).
- Distributive: $\mathbf{A} \times (\mathbf{B} + \mathbf{C}) = \mathbf{A} \times \mathbf{B} + \mathbf{A} \times \mathbf{C}$.
- Not associative: $\mathbf{A} \times (\mathbf{B} \times \mathbf{C}) \neq (\mathbf{A} \times \mathbf{B}) \times \mathbf{C}$ in general (be careful when multiple cross appear).
- If $\mathbf{A} \times \mathbf{B} = \mathbf{0}$, it implies either **A** or **B** is zero or they are parallel/collinear. This is useful to test if two direction vectors are parallel (like forces along the same line yield zero moment about a point on that line).

Common exam traps:

- **Forgetting the negative on the j-component:** The most frequent error in manual cross product is to drop the minus sign for the j term. Memorize the pattern ($\mathbf{i}$, then $-\mathbf{j}$, then $\mathbf{k}$) or use the circled i-j-k method to keep track. If you're unsure, check with a simple example as mentioned (like cross of standard basis vectors) to see if your formula output matches known results ($\mathbf{i} \times \mathbf{j} = \mathbf{k}$, $\mathbf{j} \times \mathbf{k} = \mathbf{i}$, $\mathbf{k} \times \mathbf{i} = \mathbf{j}$).

- **Mixing up angle usage (sine vs cosine):** Cross product uses sine. If an exam problem gives magnitudes and the angle, and asks for the magnitude of the cross product (say a torque magnitude $M = rF\sin\theta$), don't accidentally use cosine. A good check: if the angle is 90°, cross product magnitude should be maximal (gives product of magnitudes), whereas dot product would be zero. So if you plug 90° and your formula gives 0, you picked the wrong trig function.

- **Wrong direction due to right-hand rule mistakes:** Some students use left-hand or just guess. Practice the right-hand rule: it can feel awkward under pressure, so physically do it if needed. Align your right-hand fingers along **A**, then sweep toward **B**. If you overshoot 180° (i.e., if you'd go the long way around >180°), adjust – the smaller rotation from **A** to **B** is what your fingers follow. The thumb then gives direction. If an answer asks for a vector (like moment in vector form), a wrong sign on one component might mean you conceptually did **B**×**A** or used left-hand rule. Note that if the question says "find the magnitude of the moment" you can just give a positive number (no direction needed), but if it says "find the moment vector" or similar, direction matters.

- **Dimension confusion:** Ensure you provide a vector answer for a cross product problem (unless only magnitude asked). And if mixing units, say $\mathbf{r}(m) \times \mathbf{F}(N)$, label the result as N·m (but as a vector in the appropriate direction). On the exam, a moment of 30 N·m in the +k direction might be given as $30\mathbf{k}$ N·m, for example.

Exam Handbook Search Cues (Not affiliated with or endorsed by NCEES): *cross product; vector product; A × B; right-hand rule; perpendicular vector; moment arm*

[^11]: In 2D statics problems, you might have learned to compute moments as $M = F \times d$ (force times perpendicular distance). That's actually a stripped-down cross product concept: if force lies in the plane, the moment comes "out of" the plane. Many exam problems in mechanics avoid explicit cross products by using scalar moment calculations with sign conventions. But if you're comfortable with cross products, feel free to use them to derive the correct sign automatically (just be sure of your coordinate system orientations). For example, taking $\mathbf{r} \times \mathbf{F}$ with **r** from pivot to application point and **F** in-plane, you'd get a ±k moment; +k could be "out of page" which you might call positive moment by convention. Keep track of what positive means in the problem's context.

[^12]: **Micro-check:** Suppose **A** is along +x and **B** is along +y. Without doing any calculation, $\mathbf{A} \times \mathbf{B}$ should point along +z (right-hand rule). Now if we swapped them, $\mathbf{B} \times \mathbf{A}$, it should point along -z. This checks the anti-commutative property. If you ever doubt your cross product direction, test a simplified analogous case to recalibrate. Another one: $\mathbf{i} \times \mathbf{i} = \mathbf{0}$ (since angle is 0, sin0=0). If your formula doesn't give zero when the vectors are identical, something's off.

Explanation & analysis: The cross product expands your vector toolbox by giving an operation that yields a vector result orthogonal to the inputs. In mechanics, this is crucial for defining rotation effects. A classic scenario: a wrench of length **r** applied with force **F** – the turning effect (torque) is $\mathbf{M} = \mathbf{r} \times \mathbf{F}$. The magnitude $M = rF\sin\theta$ is the product of the force and the lever arm (perpendicular distance), which matches what you learn in statics. The direction of M (via right-hand rule) tells you the axis of rotation and whether it's clockwise or counterclockwise (depending on coordinate orientation). In the exam context, you might get a question asking for a moment vector given a force at some coordinates – using cross product in component form will directly give you M_x, M_y, M_z. Alternatively, the dot product cannot do this; it would just give a scalar related to alignment, not rotation. So knowing when to use dot vs cross is key: dot for projections/angles, cross for perpendicular vectors/rotation. Another application: given two direction vectors in space, their cross product gives a normal to the plane they define – which is useful if, say, you need to find an equation of a plane or a perpendicular direction to both vectors (for instance, to find a line of intersection direction as perpendicular to a normal vector, etc. – more a math problem but could sneak in). Keep in mind, though, cross product is inherently 3D. For 2D, when we talk about cross product, we often interpret the result as a scalar k-component (like "moment = 20 k out-of-plane"). The exam might not explicitly state "cross product" in a 2D question but implicitly uses the concept. In summary, the cross product is your go-to for anything involving "perpendicular to both" or rotational effects. When writing the result, always include direction (with a unit vector or sign convention) unless only magnitude is asked. And double-check extreme cases: if vectors align, result should vanish; if they're perpendicular, magnitude is straightforward. By practicing these, you'll reduce mistakes and increase confidence in using the cross product under exam conditions.

K01.T04.S07 – Vector Projections and Components

Principle introduction:

- A **vector projection** is essentially "dropping" one vector onto another to see how much of it lies in that direction. If you have a vector **B** and you want to find its projection onto another vector **A**, you are finding a new vector that is parallel to **A** (or in the exact opposite direction if the projection is negative) that represents the component of **B** along **A**.
- The **scalar component** of **B** along **A** is given by $B_{\parallel} = |\mathbf{B}|\cos\theta$, where θ is the angle between **A** and **B**. Another way to compute this is $B_{\parallel} = \frac{\mathbf{A}\cdot\mathbf{B}}{|\mathbf{A}|}$ – literally, the dot product gives $|\mathbf{A}|\,|\mathbf{B}|\cos\theta$; dividing by $|\mathbf{A}|$ leaves $|\mathbf{B}|\cos\theta$. This scalar could be positive (if the component is in the same direction as **A**), negative (if opposite), or zero (if perpendicular).
- The **projection vector** of **B** onto **A** takes that scalar component and points it along **A** (usually along the direction of **A**). If **A** is not a unit vector, you need to account for its length. The formula for the projection vector is:

$$\text{proj}_{\mathbf{A}}\mathbf{B} = \frac{\mathbf{A}\cdot\mathbf{B}}{\mathbf{A}\cdot\mathbf{A}}\,\mathbf{A}$$

  which can also be written as $\left(\frac{\mathbf{A}\cdot\mathbf{B}}{|\mathbf{A}|^2}\right)\mathbf{A}$. Essentially, you scale vector **A** by the fraction of **B** that lies along **A**.
- If **A** is a unit vector (magnitude 1), this simplifies nicely to $(\mathbf{A}\cdot\mathbf{B})\mathbf{A}$, since dividing by $|\mathbf{A}|^2 = 1$ changes nothing. That's why often we prefer to use unit direction vectors when finding components: it makes the math straightforward.

- Decomposing a vector into components is closely related. For example, in 2D, any vector **B** can be broken into an *x*-component and *y*-component. This is effectively projecting **B** onto the x-axis (unit vector **i**) and onto the y-axis (unit **j**). Indeed, $B_x = \mathbf{i} \cdot \mathbf{B}$, $B_y = \mathbf{j} \cdot \mathbf{B}$. So projections generalize that idea to any arbitrary direction, not just the coordinate axes.
- In the FE exam, you might need to find the component of a force in a certain direction (for example, the component of a force along a strut, or the shadow of a vector on a plane). Using projection formulas ensures you get the correct magnitude with sign. Alternatively, you may break vectors by geometry (using angles and trigonometry), but the projection approach via dot product is often quicker and less error-prone if you have the direction vector readily available.

Diagram Passport – Vector Projection

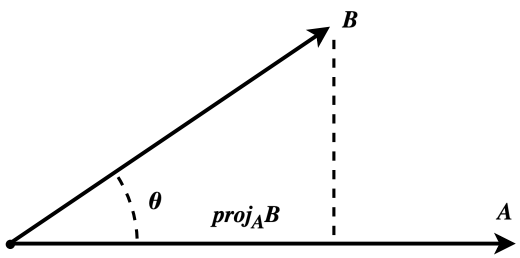

Illustration of projecting vector B onto vector A. The projection of B onto A is the vector representing B's component along A. Geometrically, it's as if we cast a shadow of B onto the line of A. The dashed line shows dropping a perpendicular from the tip of B onto A's line. The angle between A and B is θ. In this diagram, $\text{proj}_A B$ *is shorter than B, indicating B is not fully aligned with A (since θ is not zero). If θ were 0, B would lie entirely along A and the projection would equal B. If $\theta = 90°$, the projection would collapse to a zero vector.*

Definition/Note Passport – Projection Formula
Plain-language definition: The projection of **B** onto **A** is the vector you get when you "shine" **B** straight down onto the line defined by **A**. It answers: "How much of **B** is pointing along **A**?" It's given by the formula:

$$\text{proj}_{\mathbf{A}}\mathbf{B} = \frac{\mathbf{A} \cdot \mathbf{B}}{\mathbf{A} \cdot \mathbf{A}}\,\mathbf{A}.$$

In words, take the dot product of **B** with **A** (that gives $|\mathbf{A}|\,|\mathbf{B}|\cos\theta$), normalize by $\mathbf{A} \cdot \mathbf{A} = |\mathbf{A}|^2$ to account for **A**'s length, and multiply by **A** to give a vector in **A**'s direction.

Where it matters (exam impact): You'll use projections any time you need a component of a vector in a non-orthogonal direction. For instance, finding the component of a weight force along an inclined plane (instead of horizontal/vertical), or the portion of a velocity in some specified direction. The exam might explicitly ask for a projection or just implicitly require it in solving a problem (e.g., resolving forces along a line of action). Mastering the projection formula means you don't have to re-derive by drawing right triangles each time – you can compute it directly with dot products.

Pitfall or confusion point: Make sure you identify *which vector onto which*. $\text{proj}_A B$ is generally **not** the same as $\text{proj}_B A$ unless the vectors are parallel. The formula's numerator $\mathbf{A} \cdot \mathbf{B}$ is commutative, but the denominator and the final direction are tied to **A**. So $\text{proj}_A B$ yields a vector parallel to **A**, whereas $\text{proj}_B A$ would be parallel to **B**. Always read "projection of **(this)** onto **(that)**" carefully. A good check: the resulting vector should align with the *onto* vector (the second one). If it doesn't, you inverted something. Also, remember that if the result comes out longer than **B** itself (in magnitude), something's off – you can't have a component longer than the original vector (except sign, but sign just flips direction).

Micro-check: If **A** is already a unit vector, does the formula simplify? Yes – if $|\mathbf{A}| = 1$, then $\text{proj}_A B = (\mathbf{A} \cdot \mathbf{B})\,\mathbf{A}$. For a quick mental check, imagine **A** = **i** (unit x-direction) and **B** has components (5, 2). Projecting **B** onto **i** should yield (5, 0), since 5 is the x-component of **B**. Using the formula: $\mathbf{i} \cdot \mathbf{B} = 5$; multiply by **i** gives $5\mathbf{i} = (5,0)$. It works out. If **A** was not unit, say **A** = (2,0) (so basically 2**i**), projecting the same **B** onto **A**: $\mathbf{A} \cdot \mathbf{B} = 10$; $\mathbf{A} \cdot \mathbf{A} = 4$; formula gives $\frac{10}{4}(2,0) = (5,0)$ again. Consistency check passed.

Exam Handbook Search Cues (Not affiliated with or endorsed by NCEES): *vector projection; component of A in direction B; resolve vector; dot product usage*

[^13]: It's easy to confuse "projection of B onto A" with "component of B perpendicular to A" – the latter would actually be $\mathbf{B} - \text{proj}_A B$. Some problems might indirectly ask for the perpendicular component (for instance, if you want the component of a force causing shear versus along a member). Just remember: once you have the projection (parallel part), subtracting it from the original gives the perpendicular part. If you ever find yourself needing the part of **B** orthogonal to **A**, compute $\mathbf{B}_\perp = \mathbf{B} - \text{proj}_A \mathbf{B}$. This resultant is orthogonal to **A** by construction.

[^14]: In 3D, projections are often used to find angles between lines and planes, etc. For example, to find the angle between a vector and a plane, you might project the vector onto the plane and then use dot products. While such specifics may be more common in civil/structural or academic problems, it's good to know the projection concept extends: essentially, you're stripping away the component you don't want (like the component perpendicular to the plane, leaving the in-plane component). Keep an eye out: sometimes a problem might give two vectors and a plane normal, and ask something like "find the component of force in the plane" – that's a projection scenario where you subtract out the normal component.

Explanation & analysis: The idea of breaking vectors into components is second nature in engineering. We usually do it along convenient perpendicular axes (x and y, or maybe tangential and normal, etc.). The projection formula is just a generalized way to get those components along any direction. It leverages the dot product because dotting with a unit vector gives the amount in that direction. One intuitive way to derive the projection is: take a unit vector $\hat{\mathbf{a}}$ in direction of **A**. Then the component of **B** along that is simply $\mathbf{B} \cdot \hat{\mathbf{a}}$. Multiply that scalar by $\hat{\mathbf{a}}$ again to turn it into a vector in that direction: $(\mathbf{B} \cdot \hat{\mathbf{a}})\hat{\mathbf{a}}$. And indeed, $\hat{\mathbf{a}} = \frac{\mathbf{A}}{|\mathbf{A}|}$, so plugging that in: $\left(\mathbf{B} \cdot \frac{\mathbf{A}}{|\mathbf{A}|}\right)\frac{\mathbf{A}}{|\mathbf{A}|} = \frac{\mathbf{A} \cdot \mathbf{B}}{|\mathbf{A}|^2}\mathbf{A}$. Same formula. Understanding it this way highlights: you first normalize the "onto" vector, then scale it. On the exam, using projections can simplify solutions. For example, if a force is at some awkward angle, and you need the component along a member that's at another awkward angle, rather than doing geometry with both angles, you can simply take a dot product of two direction vectors. It's algorithmic: find a unit vector in the desired direction, dot with the given vector, multiply by that unit vector.

This can be less error-prone than resolving into horizontal/vertical then again into the member's direction. Also, note that projection can yield a negative scalar if the component is opposite the direction you're projecting onto. That's fine – it just means **B** has a component in the exact opposite direction of **A**. The resulting projection vector will point opposite to **A** in that case (because the scalar multiple will be negative, essentially flipping **A**'s direction). In context, that might mean the force is actually resisting or acting opposite to the assumed direction along the member. Keep the sign if you're doing a calculation like equilibrium (it will handle compression vs tension signs, etc.). However, if a problem asks for "magnitude of the component", they likely expect a positive value (just the absolute length). To avoid confusion, sometimes give the answer with a direction explicitly (e.g., "5 kN opposite to the direction of **A**" if a negative came out, or just say "magnitude 5 kN").

Topic 05 - Numerical Methods

Topic Introduction – Why It Matters: Numerical methods are techniques for obtaining approximate solutions to mathematical problems that might be difficult or impossible to solve analytically. In the FE Mechanical Exam, you'll encounter numerical methods in questions that ask about the **precision of calculations**, how **errors propagate** through computations, how to **approximate functions** using series expansions, or how to find **roots of equations** iteratively. The exam won't require you to write lengthy code, but it will expect you to know the key principles: for example, how rounding affects a final answer, how to combine uncertainties from measurements, how a Taylor series can estimate a function's value, or how the Newton–Raphson method finds solutions. Numerical methods questions are often conceptual or involve a **single iteration or estimate** rather than a full computation. By mastering these concepts, you'll avoid common pitfalls (like rounding too aggressively or confusing accuracy with precision) and confidently tackle approximation and root-finding problems on exam day.

K01.T05.S01 – Accuracy and Precision, Significant Figures & Rounding

Principle Introduction (Key Ideas):

- **Accuracy vs. Precision:** *Accuracy* refers to how close a measured or computed value is to the true value, whereas *precision* refers to how consistent or repeatable the measurements are. It's possible to be precise but not accurate (clustered results far from true value) or accurate on average but not precise (results scattered around the true value). In exam questions, knowing the difference helps identify errors in measurement and instrumentation contexts.
- **Significant Figures:** The number of significant figures in a value indicates its measured or reported precision. More significant digits imply a more precise (but not necessarily accurate) value. The FE exam typically provides data to 3–4 significant figures, and your answers should generally reflect a similar precision unless instructed otherwise.
- **Rounding Impacts:** Rounding too early or too much can introduce *round-off error*. Small rounding differences can compound through multi-step calculations, potentially leading to a noticeably different result. On the exam, it's best practice to carry a few extra digits through calculations and round your final answer to the appropriate significant figures. The exam's scoring typically tolerates minor numerical differences due to reasonable rounding, but gross rounding errors can make an answer fall outside the accepted range.

Definition Passport – Accuracy

- **Definition:** *Accuracy* is the closeness of a reported value to the true or accepted value. A highly accurate measurement has very little systematic error (bias). In other words, it hits the "bullseye" of the true value.

- **Where it matters (exam impact):** Accuracy is usually referenced in problems involving **measurement instruments or calibration**. A question might ask which measuring device is more accurate or to identify the effect of a systematic error on a result.

- **Pitfall:** Don't confuse accuracy with precision. High accuracy does not require repeated measurements—just that the single measurement (or average of measurements) is correct on target. A common mistake is calling a tightly clustered set of wrong values "accurate," when it's actually **precise but inaccurate** (all readings consistent but off-target).

- **Micro-check:** *True/False:* It is possible for a set of measurements to be **highly precise** but **inaccurate** (answer: True, if they're consistently off from the true value due to calibration bias).

Definition Passport – Precision

- **Definition:** *Precision* refers to the repeatability or consistency of measurements. High precision means if you measure the same quantity multiple times, you get nearly identical results each time (with minimal random error or scatter).

- **Where it matters (exam impact):** Precision often comes up when discussing **instrument quality or data scatter**. On the FE, you might be asked about the implications of a large spread in repeated measurements (indicating low precision) or about significant figures which reflect the precision of a reported number.

- **Pitfall:** Precision is not the same as accuracy. A highly precise instrument can still be mis-calibrated (so it's consistently off the true value). Conversely, an accurate instrument might give results centered on the true value but show some scatter. Always identify if a question is talking about **spread (precision)** versus **bias (accuracy)**.

- **Micro-check:** *Fill-in:* A **precise** set of measurements has (high/low) variance? – **Low** variance (the readings are tightly clustered).

Definition Passport – Significant Figures

- **Definition:** *Significant figures* are the digits in a number that carry meaning contributing to its precision. This includes all certain digits and the first uncertain digit in a measurement. For example, 2.530 has four significant figures, indicating a relatively precise measurement.

- **Where it matters (exam impact):** In reporting numerical answers on the FE, using the appropriate significant figures is important for clarity and to reflect input precision. Some exam problems might subtly test if you understand how rounding and significant digits work—e.g. by seeing if you carry enough precision through a multi-step calculation.

- **Pitfall:** A common mistake is miscounting significant zeros. **Leading zeros** (e.g. 0.0032) are not significant (they're placeholders), whereas **captive zeros** (e.g. 1005) are significant, and **trailing zeros** are significant if there's a decimal point (e.g. 50.0 has three sig figs). Also, when performing calculations, remember that different operations have different rules for how results are rounded (addition/subtraction use decimal places; multiplication/division use total sig figs).

- **Micro-check:** How many significant figures are in the measurement 0.004560? – **4 significant figures** (4560 are significant; the leading zeros are not).

Exam Handbook Search Cues (Not affiliated with or endorsed by NCEES): *accuracy, precision, significant figures, rounding* (These keywords will help you locate reference material in the exam handbook, which lists definitions and rules for significant digits and measurement accuracy.)

Footnotes:

- It's generally sufficient to report **3 to 4 significant figures** for final answers on the FE Exam. The exam's scoring mechanism accounts for slight differences due to rounding, so don't panic if your answer differs by a tiny amount from an integer answer choice – it may be due to rounding tolerance.
- The bullseye analogy: *Accuracy* is like hitting the center of a dartboard; *precision* is like hitting the same spot consistently, even if it's off-center. Keeping this analogy in mind can help you quickly classify errors in exam questions.
- FE-approved calculators often have a mode or setting for the number of displayed decimal places. Be cautious: setting it to too few decimals could hide needed precision. It's best to carry extra digits in calculations (use your calculator's memory or ANS feature) and round only at the end.

Variations, Related Forms, Typical Values:

- **Reporting Answers:** Unless a problem specifies, report answers with a practical level of precision (usually 2–4 significant figures). For instance, a computed stress of 3,256,789 Pa might reasonably be given as $3.26 \times 10^6 Pa$ if appropriate. Extremely high precision (e.g., 10 significant figures) is neither needed nor realistic for FE problems.
- **Significant Figure Rules:** In **addition or subtraction**, align the decimal points – the result should be rounded to the least number of decimal places of any operand. In **multiplication or division**, the result should have no more significant figures than the least precisely known factor. For example, 12.5 (three sig figs) ÷ 3.42 (three sig figs) should yield a result with three sig figs.
- **Percent Error:** A related concept to accuracy is *percent error*, calculated as percent error $= \frac{\text{measured}-\text{true}}{\text{true}} \times 100\%$. A small percent error indicates high accuracy. Typical calibration problems may expect you to compute this if given true vs measured values.
- **Rounding Methods:** The conventional rounding rule is to round up on ≥5 and round down on <5 in the next digit. Be aware of the special case of **stochastic rounding** or guard digits (not typically needed on the FE) – the exam will assume standard rounding unless stated otherwise. Always round *final answers* appropriately, but avoid rounding intermediate steps too harshly.

Explanation & Analysis (Step-by-Step): Accuracy and precision form the conceptual foundation for dealing with experimental data and results on the FE exam. If a question presents two measuring devices, you may be asked which one is more accurate (gives readings closer to the standard value) or more precise (gives more consistent readings). Recognizing keywords like "**systematic error**" (which affects accuracy by introducing bias) versus "**random error**" (which affects precision by causing scatter) will guide your reasoning. Significant figures are the bridge between the concepts of precision and the numerical results you calculate: they are an explicit way to state, "this is how much confidence we have in these digits." When you perform calculations, each operation can only be as precise as the least precise input.

Let's break down a quick example: Suppose you use a steel ruler (with marks to the nearest millimeter) to measure a length and get 12.3 cm. The **precision** of this measurement is about ±0.05 cm (half the smallest division), so it has three significant digits. If the true length was 12.5 cm, your measurement's **accuracy** has a slight error (–0.2 cm off). Now, if you use this length in further calculations (say computing area with another measured dimension), the uncertainties from both measurements will combine. This is why keeping an appropriate number of significant figures through the calculation is critical – it preserves the information about uncertainty. On the exam, a typical trap is to round off too early. For example, if you have an intermediate calculation yielding 3.998, and the final result needs that value, do not round 3.998 to 4.0 until the end – carrying the extra precision (maybe keep it as 3.998 or 3.9980 in your calculator memory) ensures your final answer isn't skewed.

In summary, treat significant figures as a tool to communicate precision. Use accuracy and precision concepts to diagnose errors: if results are consistently off in one direction, think accuracy (systematic error); if they're wildly variable, think precision (random error). And when doing numerical calculations, guard against rounding errors by working carefully – the exam will reward an understanding of when and how to round.

K01.T05.S02 – Error and Uncertainty Propagation in Calculations

Principle Introduction (Key Ideas):

- **Uncertainty Propagation:** When a result is calculated from multiple measured or estimated inputs, each with its own uncertainty, the result's uncertainty depends on all of them. Numerical methods provide formulas (like the Kline–McClintock formula) to *propagate* uncertainties through a calculation. In FE problems, you might be given uncertainties (or tolerances) in measurements and asked to find the uncertainty in a quantity computed from those measurements.
- **Random vs. Systematic Errors:** *Random errors* cause measurement scatter and are handled with statistical uncertainty propagation. *Systematic errors* (biases) don't cancel out by averaging and require calibration or correction rather than propagation. The FE exam's focus is usually on the former—combining standard deviations of independent errors.
- **Conservative Estimates:** Often, uncertainties are combined in quadrature (root-sum-of-squares) rather than simple addition. This method assumes independent error sources and tends to give a realistic combined uncertainty without overestimating. Recognize phrases like "standard deviation" or "± value" as cues to apply uncertainty formulas.
- **Significance of Results:** After propagating error, the **relative uncertainty** (percentage uncertainty) in the result can tell you if the result is high quality. For example, a 1% uncertainty in a final answer is typically very tight, whereas 50% means the result is very rough. The exam might not ask for this explicitly, but

understanding it can guide you to avoid unreasonable answers (if your uncertainty ends up larger than the value itself, something's off!).

Equation Passport – Kline–McClintock Uncertainty Formula
Name & Purpose: *Kline–McClintock Equation* – calculates the standard uncertainty of a result y that is a function of several independent variables, each with a known standard uncertainty. This formula provides a way to combine individual errors into an overall error for y. It's widely used in engineering experiments and measurements to estimate how measurement tolerances propagate to a final computed quantity.

Equation:

$$\sigma_y = \sqrt{\left(\frac{\partial y}{\partial x_1}\,\sigma_{x_1}\right)^2 + \left(\frac{\partial y}{\partial x_2}\,\sigma_{x_2}\right)^2 + \cdots + \left(\frac{\partial y}{\partial x_n}\,\sigma_{x_n}\right)^2}$$

where $y = f(x_1, x_2, \ldots, x_n)$. This is the root-sum-of-squares of each input's uncertainty contribution.

Variables and Units:

- σ_y – standard deviation (uncertainty) of the result y (in the same units as y).
- x_i – an input variable (with units as given in the problem, e.g. length, time, etc.).
- σ_{x_i} – standard deviation (uncertainty) of x_i (same units as x_i).
- $\frac{\partial y}{\partial x_i}$ – partial derivative (sensitivity) of function f with respect to x_i (units of y per unit of x_i). This term shows how much a small change in x_i affects y.

Assumptions and Scope:

- **Independence:** The formula assumes the input uncertainties are uncorrelated (independent). Each term is added in quadrature (RSS) rather than linearly, which is valid when errors are random and independent. If two variables' errors were correlated (not typical in FE exam unless stated), this formula would need additional covariance terms.

- **Small Errors (Linear Approximation):** It assumes the function f can be linearized around the nominal values of x_i. In practice, this means the uncertainties are relatively small such that higher-order terms are negligible. Large uncertainties or strongly nonlinear f would require more complex analysis, but FE problems stick to well-behaved cases.

- **Standard Uncertainties:** σ_{x_i} are treated as standard deviations (1σ). If a problem gives "±" values, you assume those are one standard deviation (or some confidence interval convertible to σ). In exam context, they'll usually either explicitly state it or provide data in a way that using this formula directly is appropriate.

Limit Tests (Sanity Checks): If all but one uncertainty σ_{x_k} are zero, the formula reduces to $\sigma_y \approx \left|\frac{\partial y}{\partial x_k}\right| \sigma_{x_k}$. In other words, if only one input has uncertainty, all the output uncertainty comes from that source (which makes sense). As any $\sigma_{x_i} \to 0$, it drops out of the square-root sum. Also note that σ_y will always be non-negative, and tends to grow as you add more sources of uncertainty.

Extreme case: if you have two independent error sources of equal magnitude, the combined uncertainty is $\sigma_{\text{combined}} = \sqrt{\sigma^2 + \sigma^2} = \sigma\sqrt{2} \approx 1.414\sigma$, which is higher than each alone but not simply additive – a reasonable middle ground (this test helps prevent the mistake of just adding uncertainties directly).

Use vs. Sibling Equations: Use this Kline–McClintock equation (error propagation formula) whenever you need the **uncertainty of a calculated result** given uncertainties in the inputs. Use this instead of simple addition of errors. For example, if you add two lengths $L = L_1 + L_2$ (each with some uncertainty), a naive approach might add absolute uncertainties, but the correct approach is to add variances: $\sigma_L = \sqrt{\sigma_{L1}^2 + \sigma_{L2}^2}$. Similarly, for a product $y = AB$, you wouldn't add absolute uncertainties; instead you'd add relative uncertainties in quadrature.

Important: If a problem is straightforward (like a sum or difference), you can apply simplified forms (see variations below), but they are all consistent with this general formula.

Common Exam Traps:

- **Mixing Up Percentage and Absolute Uncertainty:** Sometimes a problem might give percentage uncertainties. You can use the formula by converting those to absolute σ values (e.g. 5% of x as σ). Or use the fractional form: for $y = A \cdot B$, $\left(\frac{\sigma_y}{y}\right)^2 = \left(\frac{\sigma_A}{A}\right)^2 + \left(\frac{\sigma_B}{B}\right)^2$. Forgetting to use the fractional form for multiplicative relationships is a common mistake.

- **Incorrect Differentiation:** If you have to derive $\frac{\partial y}{\partial x_i}$ for a formula, do it carefully. For example, if $y = x^2$, then $\partial y/\,\partial x = 2x$. Plug in the nominal value of x to evaluate the sensitivity. Using the wrong derivative or value will give a wrong contribution.

- **Overestimating Uncertainty:** Avoid the temptation to just add uncertainties linearly unless the variables truly add (and even then, if signs of errors can cancel, RSS is appropriate). The exam might include a distractor answer that is simply the sum of uncertainties, which would be incorrect if the proper method is root-sum-square. Also, remember that this formula is for *small, random* errors. If a problem hints at a **bias** (like all measurements are off by +0.5 due to calibration), that systematic error should be handled separately (often simply added after combining random errors).

Exam Handbook Search Cues (Not affiliated with or endorsed by NCEES): *error propagation, uncertainty, standard deviation, Kline* (The exam handbook may list this topic under terms like "Propagation of Error" or "Measurement Uncertainty." Look for those keywords to find relevant formula references.)

Footnotes:

- In engineering, the terms *precision* and *uncertainty* are often used interchangeably in context. A ± **value** given for a measurement is typically one standard deviation (~68% confidence) or half the range of a confidence interval. For the FE, assume it's one standard deviation unless told otherwise.
- When a formula is simple, you can derive quick rules: e.g., if $y = X + Z$, then $\sigma_y = \sqrt{\sigma_X^2 + \sigma_Z^2}$. If $y = X - Z$, the same formula applies (subtraction doesn't reduce combined uncertainty; the difference's uncertainty still adds in quadrature). If $y = X \cdot Z$ or $y = X/Z$, use percentage uncertainties: $\left(\frac{\sigma_y}{|y|}\right)^2 = \left(\frac{\sigma_X}{X}\right)^2 + \left(\frac{\sigma_Z}{Z}\right)^2$. It's good to remember these special cases for quick estimates.

- **Calculator Tip:** When calculating with uncertainties, it can help to compute the result at the nominal values, then recompute by nudging each input by its ± uncertainty to see the effect. However, that's time-consuming. Instead, use the formula. If you do program your calculator for repetitive tasks, make sure you input the partial derivatives correctly. Most likely, the FE exam problems on this are direct enough that plugging into the formula by hand is faster.

Variations, Related Forms, Typical Values:

- **Simplified Forms:** As noted, the general formula yields simpler forms for specific cases:
- *Sum/Difference:* $y = u \pm v \Longrightarrow \sigma_y = \sqrt{\sigma_u^2 + \sigma_v^2}$. The uncertainty in a sum or difference depends on both uncertainties added in quadrature. For example, adding two lengths 5.0 ±0.1 and 3.0 ±0.2 (units same) gives $y =$ 8.0 and $\sigma_y = \sqrt{0.1^2 + 0.2^2} = 0.223$ (so about ±0.22).
- *Product/Quotient:* $y = uv$ or $y = \frac{u}{v} \Longrightarrow \left(\frac{\sigma_y}{|y|}\right)^2 = \left(\frac{\sigma_u}{u}\right)^2 + \left(\frac{\sigma_v}{v}\right)^2$. The *relative* uncertainty of a product or ratio is the RSS of relative uncertainties of the factors. If area $A = L \times W$, and L has 2% uncertainty and W has 3%, then A has $\sqrt{2^2 + 3^2} \approx 3.6\%$ uncertainty.
- *Power Law:* If $y = u^p$ (e.g., volume $\propto length^3$), then $\frac{\sigma_y}{|y|} = |p|\frac{\sigma_u}{|u|}$. For instance, if you measure a radius r with 1% uncertainty, the area $A = \pi r^2$ has 2% uncertainty (because $p = 2$).
- **Typical Values:** In many engineering measurements, a 1–5% uncertainty is considered good/acceptable, 5–10% is moderate, and >10% is high. The FE exam might give values in these ranges. Be wary of any result that implies >100% uncertainty (that would mean the "error" is larger than the value itself!). If you ever calculate something like that, double-check the math.
- **Absolute vs. Relative Uncertainty:** Keep track of units. Absolute uncertainty σ_y has units of y. Sometimes it's more insightful to report a **relative uncertainty** ($\sigma_y/|y|$) as a percentage. On the exam, either format might be expected depending on how the question is phrased. If a question asks "What is the uncertainty in the computed value?", giving an absolute ± value in proper units is safe. If it asks for "percentage error" or similar, give a percentage.
- **Confidence Levels:** The formula as given deals in standard deviations. If the exam problem mentions a **confidence interval (e.g., 95%)** with a coverage factor (like $k = 2$), that means $\pm 2\sigma$. For example, a length is $(20.0 \pm 0.5)\ cm$ at 95% confidence. Here 0.5 cm is about 2σ, so σ≈0.25 cm. Use σ=0.25 in calculations, then if needed, express final uncertainty as ± something at 95%. Usually, though, the FE won't get this deep into statistical nuance; you'd just use 0.5 directly if the context is clear.

Explanation & Analysis (Step-by-Step): Error propagation analysis on the FE is typically straightforward: identify the formula or relationship linking variables, plug in uncertainties. For example, imagine a problem: *"A cylindrical tank's volume $V = \pi D^2 h/4$ is calculated from a measured diameter $D = 1.200$ m (±0.005 m) and height $h = 5.00$ m (±0.02 m). What is the uncertainty in the volume?"* To solve, you'd first compute V nominally, then apply the propagation formula. The partial derivatives: $\partial V/\partial D = \pi(2D)h/4 = \frac{\pi D h}{2}$; $\partial V/\partial h = \pi D^2/4$. Plug values: $D \approx 1.2, h = 5.00$. Then $\sigma_V = \sqrt{\left(\frac{\pi(1.2)(5.00)}{2} \cdot 0.005\right)^2 + \left(\frac{\pi(1.2)^2}{4} \cdot 0.02\right)^2}$. Crunching that gives the volume uncertainty. The key steps are: **(1)** determine each input's uncertainty and nominal value; **(2)** find how sensitive y is to each input (via derivative or proportionality); **(3)** compute each contribution and take the root-sum-square.

Physically, what is this doing? It's treating the small changes in each input as if they independently cause changes in output y. The partial derivative $\partial y/\partial x_i$ is like saying "if x_i wiggles by a tiny bit, y will wiggle by that derivative times the amount." By squaring and summing, we assume those wiggles occur in random directions (sometimes one input's error might make y bigger, another's might make it smaller, etc.). The RSS method accounts for that without unrealistically assuming worst-case all errors push the same way.

On exam day, watch out for wording: if they say **"tolerance"** or **"maximum error"**, they might expect a simple addition of absolute uncertainties for a conservative upper bound. But if they use **"standard deviation"**, **"uncertainty"**, or **"propagate"**, that's your cue for the quadrature method (like the Kline–McClintock formula). Always double-check units when combining terms – each term inside the square root should be in the same units, which is assured if you've correctly used the derivative (e.g., converting percentage to absolute if needed). If something doesn't match (one term in inches, another in feet), convert before squaring.

In summary, uncertainty propagation is about being **methodical**: treat each error source carefully and combine them correctly. The FE won't throw overly complex scenarios, so if you see an error propagation question, gather the given ± values, identify the formula, and apply these rules. You'll typically find one of your answer choices matches the computed uncertainty (often the one using RSS). Recognizing that choice (and not the larger one that would come from linear addition) often signals you did it right.

K01.T05.S03 – Series Approximations of Functions (Taylor Series & Truncation Error)

Principle Introduction (Key Ideas):

- **Taylor Series Expansion:** A Taylor series expresses a function as an infinite sum of terms formed from the function's derivatives evaluated at one point. It's a powerful tool to approximate function values. If a function is well-behaved (smooth) around a point a, we can expand $f(x)$ about a and truncate the series after a few terms to get an approximate value for $f(x)$. On the FE exam, you might need to recall basic series expansions (like for e^x, $\sin x$, $\cos x$, etc.) or to identify the next term's size to estimate error.
- **Maclaurin Series:** This is a special case of the Taylor series centered at $a = 0$. Many common expansions are given as Maclaurin series, e.g. $e^x = 1 + x + \frac{x^2}{2!} + \frac{x^3}{3!} + \cdots$. Recognize the term **"Maclaurin series"** as just a Taylor series about zero. In an exam context, they might not use the word Maclaurin explicitly, but knowing it helps if they do.
- **Truncation Error:** When you cut off a series after a finite number of terms, the difference between the true function value and your truncated series sum is the *truncation error*. The Taylor series remainder term gives a bound or estimate of this error. For a function with sufficient derivatives, the Lagrange form of the remainder

after n terms is $R_n = \frac{f^{(n+1)}(\xi)}{(n+1)!}(x-a)^{n+1}$ for some ξ between a and x. The exam may not ask you to derive that, but it could ask conceptually "if you use only two terms of a series, what's the order of the error?" or give you numeric values to compare approximation vs true.

- **Convergence:** A series has an interval (or radius) of convergence where the approximation is valid. For example, the Maclaurin series for $\ln(1+x)$ converges for $-1 < x \leq 1$. Typically, FE questions stick to series that converge for the values of interest, so you won't usually have to test convergence beyond maybe recognizing a divergent series scenario. But it's good to remember: if you try to approximate too far from the expansion point, the series may diverge or give a poor approximation even if it converges (slowly).
- **Use Cases on Exam:** The FE might directly give a series and ask what function it represents, or give a function and ask for the approximate value using a couple of terms. Or they might test if you know the series form of common functions (like $\sin x \approx x - x^3/6$ for small x). Keep an eye out for small angle approximations – those are essentially Taylor series truncations used in physics/engineering (e.g., $\sin\theta \approx \theta$ in radians when θ is small).

Equation Passport – Taylor Series Expansion
Name & Purpose: *Taylor Series Expansion* – expresses a function $f(x)$ as an infinite polynomial around a point a. This gives a way to approximate $f(x)$ by a sum of terms involving derivatives of f at a. Engineers use Taylor series to linearize functions or get polynomial approximations that are easier to compute. On the FE exam, Taylor series appear as a theoretical tool: you might need to recognize or use the first few terms for approximation or identify the error from truncating the series.

Equation (General Form):
For a function with derivatives of all orders around a:

$$f(x) = f(a) + f'^{(a)}(x-a) + \frac{f''^{(a)}}{2!}(x-a)^2 + \frac{f^{(3)}(a)}{3!}(x-a)^3 + \cdots$$

This is the Taylor series of $f(x)$ about $x = a$. If $a = 0$, this becomes the Maclaurin series:

$$f(x) = f(0) + f'^{(0)}x + \frac{f''^{(0)}}{2!}x^2 + \frac{f^{(3)}(0)}{3!}x^3 + \cdots.$$

Variables and Units:

- x – the variable at which you want to evaluate the function (same units as a, since $x - a$ must be dimensionless or in some consistent unit input). Often x is dimensionless in pure math contexts, or an angle in radians, etc.

- a – the expansion point (also sometimes called x_0 or c). This is the value around which the series is built. One often chooses a to simplify calculations (e.g., 0 for Maclaurin, or a value where derivatives are easy or the value is known).

- $f'^{(a)}, f''^{(a)}, f^{(n)}(a)$ – the first, second, up to nth derivatives of f evaluated at a. These derivatives have units of f per unit, f per $unit^2$, etc., depending on the context of f. For example, if $f(x)$ is $\sin x$ and x is in radians (dimensionless), the derivatives cycle and are likewise dimensionless. If $f(x)$ had units (say $f(t)$ is a velocity in m/s as a function of time t in seconds), then $f'^{(t)}$ is acceleration (m/s^2), etc., so each term's units correctly end up as f's units due to the $(x-a)^n/n!$ factor balancing it out. - $n!$ – factorial of n. This is a pure number (no units), grows rapidly with n. The factorial in the denominator often makes higher-order terms very small (which is why series can converge).

Assumptions and Scope:

- **Function must be differentiable:** The Taylor series formula assumes f has as many derivatives as needed at a. If a function isn't smooth (e.g., has a sharp corner or is not differentiable at a point), you can't form a Taylor series there. (On the FE, typical functions like polynomials, exponentials, trig, etc., are all smooth and fine.)

- **Local Approximation:** The series is *centered* at a. It will approximate $f(x)$ well near a. The farther x is from a, generally the more terms you need for a good approximation. If you go too far, the series might diverge. For example, the Maclaurin series for e^x converges for all x (nice!), but the Maclaurin series for $1/(1-x)$ converges only for $|x| < 1$. The exam might implicitly test this by giving an x value out of range to see if you know a series wouldn't converge or would give nonsense there.

- **Truncation and Error:** When you truncate the series after n terms, you're ignoring the rest. The *remainder term* R_n represents the truncation error. A common form for the remainder (if $f^{(n+1)}$ is continuous) is $R_n = \frac{f^{(n+1)}(\xi)}{(n+1)!}(x-a)^{n+1}$ for some ξ between a and x. This means the error is bounded by the next term (with the derivative taken at some intermediate point). For exam purposes, you can often use the next term's size (using a or x whichever gives max) as an approximate error bound.

- **Notation:** Sometimes series are written with Sigma notation: $f(x) = \sum_{k=0}^{\infty} \frac{f^{(k)}(a)}{k!}(x-a)^k$. This is the same formula in compact form. Make sure you don't confuse $f^{(k)}(a)$ (k-th derivative) with $[f(a)]^k$ (that would be wrong). The notation $f^{(0)}(a)$ means $f(a)$ itself.

Limit Tests (Sanity Checks):

If you plug $x = a$ into the Taylor series, notice $x - a = 0$, all terms after the first become 0, and you get $f(a) = f(a)$. Good. If you take just the first term beyond $f(a)$, $f(x) \approx f(a) + f'^{(a)(x-a)}$, that's the **first-order (linear) approximation** of the function near a. This is essentially the tangent line at $x = a$. As a sanity check, if x is super close to a, the linear term dominates and higher terms are negligible. If x is far, the higher power terms grow – which is a clue you might need more terms or a different expansion point. Another check: For very small $h = x - a$, the second term $f'^{(a)}h$ should be much larger than the third term $f''^{(a)h^2}/2!$ because $h^2/2$ is tiny compared to 1 when $h \ll 1$. So truncating a Taylor series is most justified when $(x-a)$ is small or after enough terms that $(x-a)^n/n!$ is tiny.

Use vs. Sibling Methods:

Use a Taylor series when you need an *analytical approximation* of a function or to evaluate a function at a point using known information at another point. This is the go-to method for series approximation. Contrast this with using direct numerical methods (like interpolation or iteration) – Taylor series is a form of

analytical expansion, not an iterative algorithm. Also, if you have an alternating series (like the alternating harmonic series) or some Fourier series, those are different expansions; stick with Taylor for power series expansions about a point. If you're approximating an integral or solving an ODE numerically, you might use other numerical methods (Euler's method, etc.), not Taylor series (unless specifically asked to derive a series solution). In short: **Use Taylor series for function approximation**; if the exam asks for an approximate value and mentions derivatives or series, Taylor/Maclaurin is the intended approach.

Common Exam Traps:

- **Forgetting the Factorial:** It's easy to forget the $n!$ in the denominator of the terms. For instance, the series for $\sin x$ is $x - x^3/3! + x^5/5! - \cdots$. Omitting the factorial will give a hugely wrong value (the series would diverge without it). Always include the factorial for each term beyond linear.

- **Wrong Derivative or Sign:** A small algebra slip can throw off the series. Example: expanding $\cos x$ at 0 should start $1 - x^2/2! + x^4/4! - \cdots$. If you got $1 + x^2/2 + \cdots$, that sign is wrong (cosine's second derivative at 0 is -1). The exam might have answer choices that correspond to missing a negative sign or a factorial – double-check by maybe plugging in an easy test value (like $x = 0$ or x small) to see if your first few terms make sense.

- **Using Too Few Terms:** If a problem asks for an approximation to a certain accuracy, make sure to include enough terms. For instance, to approximate e^x with 5% accuracy at some value, you might need 2 or 3 terms. The *truncation error* calculation (using the next term) will guide you. A common trick: the exam might not explicitly mention Taylor but could say "Using the first two terms of the expansion, estimate …" which is hinting at Taylor/Maclaurin. If you only use one term when two were needed, you'd get a less accurate answer (maybe another multiple-choice option).

- **Mismatching the Point of Expansion:** If you expand around the wrong point, your approximation at the desired point might be poor. For example, if you want $f(2.1)$ and you know $f(2)$, it's natural to expand around $a = 2$. Expanding around 0 (Maclaurin) would converge too slowly or be impractical at 2.1. Always choose a wisely (usually the one that makes $(x - a)$ small and where you can compute the needed derivatives easily). The exam usually nudges this by context.

Exam Handbook Search Cues (Not affiliated with or endorsed by NCEES): *Taylor's series, Maclaurin series, series expansion, truncation error* (In the exam reference, look for a section titled "Taylor's Series" for the general formula, and possibly some common series expansions in the mathematics section.)

Footnotes:

- For **common functions**, it helps to memorize or quickly derive a few series:
- $e^x = 1 + x + \frac{x^2}{2!} + \frac{x^3}{3!} + \cdots$ (converges for all x).
- $\sin x = x - \frac{x^3}{3!} + \frac{x^5}{5!} - \cdots$ (converges for all x; odd powers only, alternating signs).
- $\cos x = 1 - \frac{x^2}{2!} + \frac{x^4}{4!} - \cdots$ (even powers, alternating signs).
- $\ln(1 + x) = x - \frac{x^2}{2} + \frac{x^3}{3} - \frac{x^4}{4} + \cdots$ (valid for $|x| < 1$; this one is alternating and divergent at the boundary $x = 1$ very slowly).
- These might appear in exam problems either directly or indirectly (like needing $\sin(0.1)$ approximate – you can just use 0.1 for sin since higher terms are tiny).
- **Small-Angle Approximation:** A specific case worth noting: for small angles (in radians), $\sin\theta \approx \theta$, $\cos\theta \approx 1 - \theta^2/2$, and $\tan\theta \approx \theta$. The exam may use this in a dynamics or vibrations question to simplify an expression. Recognize that it's basically using the first term of the Taylor series.
- There's a **trade-off** in series approximations: more terms = more accuracy, but more computation. The FE won't ask you to sum 10 terms by hand (time-consuming!). Typically 2–3 terms at most. So if you see a series problem, expect it to be truncated early. If the problem requires high accuracy, it'll likely give you a way to achieve that with just a couple terms (like maybe x is small so the first term already gives good accuracy).
- **Calculator Note:** The series expansions are built into your calculator's math library – but on exam, you won't derive them with the calculator. However, if you needed to verify a value, you could quickly compute the actual function versus your series approximation as a check (e.g., compare $\exp(0.5)$ from calculator to $1 + 0.5 + 0.125 = 1.625$ from two-term series). The difference 1.6487 vs 1.625 tells you the error. Just be cautious with time; usually trust the math.

Variations, Related Concepts:

- **Polynomial vs. Series:** A Taylor *polynomial* is just a truncated Taylor series. It's the approximation we actually use. The term "linearization" in engineering refers to the first-order Taylor polynomial $f(a) + f'(a)(x-a)$. There are also second-order approximations including the quadratic term, etc. So if you see "linearize around $x = a$", that's a Taylor series concept (first term beyond constant).
- **Fourier Series:** Not to be confused with Taylor series, Fourier series expand periodic functions in sines and cosines. The FE Mechanical likely won't mix that into a math question on series (Fourier series might appear in vibrations or controls contexts). Just keep in mind they are different beasts; Taylor is about power series (polynomials), Fourier is about trig series.
- **Series Approximation of Integrals:** Sometimes to approximate an integral or something like $\sqrt{1 + x}$, one might expand the integrand in a series and integrate term-by-term. This is an advanced technique not likely required on the FE, but recognize that series can be used that way. For instance, $\frac{1}{1-x} = 1 + x + x^2 + x^3 + \cdots$ for |x|<1. It's a geometric series. Summation formulas for geometric or arithmetic series are a related topic, but those are finite series sums, not Taylor.
- **Typical Magnitudes:** If you truncate after n terms, the next term often gives you an idea of error. E.g., using $\sin x \approx x - x^3/6$, the next term would be $x^5/120$. If $x = 0.1$, that next term is $0.0001/120 = 8.3 \times 10^{-7}$, extremely small – so two terms are plenty. If $x = 1.0$, next term is $1/120 \approx 0.0083$, so the two-term approximation of sin at 1.0 (which is 0.8413 true) might have ~0.0083 error (that's ~1% relative). That kind of reasoning might be useful if a problem asks, for example, "Using two terms, what is the error bound for $\cos(0.5)$?" – you'd use the next term $x^4/24$ at x=0.5.

Explanation & Analysis (Step-by-Step):

Let's illustrate a typical use of Taylor series on the exam. Suppose a question states: *"Use a third-order Maclaurin series to approximate* $e^{-0.3}$*."* You know e^x's series. So, $e^{-0.3} \approx 1 + (-0.3) + \frac{(-0.3)^2}{2!} + \frac{(-0.3)^3}{3!}$. That's $1 - 0.3 + 0.045 - 0.0045 = 0.7405$. If you check on a calculator, $e^{-0.3} \approx 0.7408$. Good, we're very close (the next term would improve it further). The problem might then ask, what's the truncation error from ignoring higher terms? The next term would be $\frac{(-0.3)^4}{4!} = 0.000101$, so the error is on the order of 1×10^{-4} (0.01%). This process shows how to get a numerical approximation and gauge its accuracy.

Another scenario: *"Given* $\sin x = x - x^3/6 + x^5/120 - \cdots$, *estimate* $\sin(10°)$*."* First, convert 10° to radians: $10° = 0.1745$ rad. Now plug in $x = 0.1745$: $\sin(0.1745) \approx 0.1745 - (0.1745)^3/6$. $(0.1745)^3 = 0.0053$, divided by 6 gives ~0.00088. So sin ≈ 0.1745 - 0.00088 = 0.1736. The actual sin 10° = 0.17365, so that's spot on to four decimal places. We didn't need the x^5 term because the x^3 term was already tiny. The exam could frame this as "using the small-angle approximation" or explicitly mention series. Knowing this, you can quickly justify dropping higher terms when x is small.

In terms of analyzing the series formula: each successive term often corrects the error of the previous truncation. The factorial in the denominator grows quickly, which usually means the series converges fast (for nicely behaved functions like exp, sin, cos). But if $x - a$ is large, $(x - a)^n$ can outpace $n!$ initially, delaying convergence. Always consider the size of $(x - a)$. For instance, to expand $(1 + x)^n$ (binomial series), the series is finite if n is an integer, but infinite if n is not an integer (the general binomial series). That infinite series converges only for |x|<1. So if x is 2, you can't use it (it diverges).

One more example for conceptual understanding: think of how we sometimes use Taylor series to approximate physics formulas. The classic one is $(1 + \epsilon)^m \approx 1 + m\epsilon$ for small ϵ. That's a Taylor expansion: $f(x) = (1 + x)^m$ at $x = 0$. Indeed, $f(0) = 1$, $f'^{(0)} = m$, so $1 + mx$ is the first-order approximation. If ϵ is very small, higher terms $\binom{m}{2}\epsilon^2 + \cdots$ are negligible. The FE might not ask this directly, but it's the kind of reasoning that underlies many engineering approximations.

Wrapping up, to succeed in Taylor series questions: **identify which series to use**, write out enough terms, and keep track of factorials and signs. Use the remainder term to check if you included enough terms (especially if the problem hints at an error bound or needed accuracy). With practice, recognizing the common series and the idea of "the next term is the error" becomes second nature. And remember, if stuck, you can always differentiate a few times and plug into the formula – it's systematic, if a bit tedious, but it works every time.

K01.T05.S04 – Root-Finding and Optimization Methods (Newton–Raphson Method)

Principle Introduction (Key Ideas):

- **Iterative Root-Finding:** Many equations don't have a closed-form algebraic solution, so we use iterative numerical methods to find their roots (solutions for $f(x) = 0$). The Newton–Raphson method (often just called Newton's method) is a fast, commonly used technique to approximate roots given a reasonable initial guess. On the FE exam, you might be asked to perform one iteration of Newton's method, or to understand its convergence properties. Less commonly, other methods like bisection or secant method could be mentioned conceptually, but Newton's method is the star because of its speed (quadratic convergence near the root).
- **Newton–Raphson Method:** Newton's method uses tangent lines to converge to a root. Starting from an initial guess x_0, the method refines the guess by looking at where the tangent at $f(x_0)$ crosses the x-axis. The update formula is $x_1 = x_0 - \frac{f(x_0)}{f'(x_0)}$. Geometrically, this moves the guess closer to a root if the function is well-behaved. The process repeats: $x_{n+1} = x_n - \frac{f(x_n)}{f'(x_n)}$ until $f(x_n)$ is near zero.
- **Convergence and Pitfalls:** Newton's method converges very fast *if* the initial guess is close enough to the actual root and $f'^{(x)}$ is not zero or too small at the root. However, if you start far away, Newton's can diverge or converge to a different root. Also, if the function's derivative is zero at the root (or becomes zero for some iterate), the method can fail or slow down drastically. On the exam, a typical question might ask, "Given one iteration of Newton's method, what is the next estimate?" or a conceptual question like "Why might Newton's method fail for $f(x) = \cdots$?" (For example, what happens if $f'(x_0) = 0$ at the initial guess?).
- **Optimization via Newton's Method:** A related concept is using Newton's method to find extrema (optimization). To find a function's minimum or maximum, you set its derivative $h'^{(x)} = 0$ and solve that using Newton's method. This leads to Newton's method of optimization, which uses second derivatives (the Hessian in multivariable cases). For the FE Mechanical, it's unlikely they'll dive deep into that, but knowing that Newton's method can find minima is a neat side note (and it uses a similar formula, replacing f with h'). Primarily, focus on root-finding for one-dimensional equations.

Equation Passport – Newton–Raphson Iteration
Name & Purpose:

Newton–Raphson Method (Newton's Method) – an algorithm to find successively better approximations to a root of the equation $f(x) = 0$. Its purpose is to solve equations numerically when an analytical solution is difficult. Start with an initial guess for the root, and apply the iteration formula to hone in on the actual root. This method is widely applicable in engineering for solving nonlinear equations (anything from finding flow rates that satisfy equations to solving implicit thermodynamic relations). In the FE exam context, you'll likely use it for a quick calculation of a root or to answer a conceptual question about convergence.

Formula (Iteration Step):

$$x_{\text{new}} = x_{\text{old}} - \frac{f(x_{\text{old}})}{f'^{(x_{\text{old}})}}$$

This yields the $(n + 1)$th estimate from the nth estimate:

$$x_{n+1} = x_n - \frac{f(x_n)}{f'^{(x_n)}}.$$

Variables:

- x_n – the current approximation of the root (units same as the variable in $f(x)$).
- x_{n+1} – the next (improved) approximation of the root.
- $f(x)$ – the function for which we seek a root $f(x) = 0$. The function's output could have its own units, but crucially $f(x)$ is zero at the root.
- $f'^{(x)}$ – the derivative of $f(x)$ with respect to x. It has units of f per unit of x. In the formula, $f(x_n)/f'^{(x_n)}$ has units of x (since it's like $\frac{\text{function value}}{\text{change in function per unit x}}$ = unit of x), which is consistent so that x_{n+1} is in the same units as x_n.

Assumptions and Scope:

- **Differentiable Function:** Newton's method assumes $f(x)$ is differentiable in the region of interest and that you can compute $f'^{(x)}$. If $f'^{(x)}$ is difficult or expensive to obtain, other methods might be preferred. But for exam problems, $f'^{(x)}$ is usually straightforward to derive.

- **Initial Guess Matters:** The algorithm converges if x_0 is sufficiently close to the actual root and if $f'^{(x_0)}$ is not too small. If you choose a poor starting point, the method might diverge or converge to a different root. The exam might avoid tricky cases, but conceptually know that Newton's can fail e.g. if $f'^{(x_n)} = 0$ (division by zero in the formula) or if the iteration jumps around chaotically.

- **Local Convergence (Quadratic):** When near the root, Newton's method converges *quadratically*, meaning the error shrinks super fast (roughly squaring at each step). This is a strong selling point – a few iterations can yield high precision. However, this analysis assumes the function behaves approximately linear near the root (no inflection or weird curvature at the root). If $f'^{(root)} = 0$ (root of multiplicity >1), convergence is slower (only linear). We assume simple roots for the usual convergence speed.

- **One Root at a Time:** Newton's finds one root per initial guess. If an equation has multiple roots, different starting points find different roots. The method itself doesn't tell you which root is "correct" – you need to choose the initial guess near the root of interest. In an FE question, if multiple roots exist, they often specify an initial guess to indicate which one you're approximating.

Limit Tests (Sanity Checks): If the function value $f(x_n)$ is zero (or extremely close), then $x_{n+1} = x_n$. That means you've found the root – the guess doesn't change further. If $f(x_n)$ is not zero but $f'^{(x_n)}$ is very small, the correction term $\frac{f(x_n)}{f'^{(x_n)}}$ will be huge, potentially sending x_{n+1} far away – a sign of trouble. In fact, if you ever compute a step that's massively larger than the current x_n, it's a red flag that Newton's method is misbehaving (maybe a bad initial guess or a local extremum near that guess causing a horizontal tangent). Another check: for a nice well-behaved function, the sequence $x_0, x_1, x_2, \ldots$ should steadily approach the root. If you find x_1 is further from the root than x_0 or oscillating, something's off. Newton's isn't guaranteed to always move closer (unlike the bisection method which always narrows the bracket), but in typical exam scenarios it will.

Use vs. Sibling Methods: Use Newton–Raphson when you need a fast convergence and can compute derivatives. It's preferred over the **bisection method** when you want speed and have a decent initial guess, because bisection converges slower (linearly) but is very robust (always converges if you start with a bracket around a root). If a question emphasizes guaranteed convergence or not needing a derivative, **bisection** or **secant method** might be mentioned: - *Bisection* halves an interval known to contain a root by checking sign changes, guaranteed but can be slow. - *Secant method* is like Newton's but approximates $f'^{(x)}$ via a difference (so you don't need the actual derivative formula). It converges a bit slower than Newton's but faster than bisection typically, and requires two initial guesses. On the FE, you're unlikely to be asked to perform secant method iterations, but you should know Newton's method's role: **use Newton's when you have an analytic derivative and need a quick result; use bisection if you only know two bounds and the function's sign and want reliability.** Also, Newton's method can be used for finding maxima/minima by applying it to $f'^{(x)} = 0$ (though then you need second derivative to classify the extremum). If asked "which method converges fastest?" Newton-Raphson is usually the answer (with the caveat of needing a good start).

Common Exam Traps:

- **Algebra Mistake in Formula:** Make sure you plug into $x_{\text{new}} = x_{\text{old}} - \frac{f(x_{\text{old}})}{f'(x_{\text{old}})}$ correctly. A common slip by students is to add instead of subtract (especially if $f(x)$ is negative, one might mistakenly do $x_{\text{new}} = x_n + |f/f'|$ which is wrong, it should follow the sign given by the formula). The subtraction is crucial because you're moving opposite the function's sign to go toward the root.

- **Using $f'^{(x)}$ at Wrong Point:** Remember it's $f'^{(x_n)}$, the derivative at the current guess. Don't use the derivative at the initial guess for all iterations; it must be updated each time. If a problem only asks for the first iteration, you just compute x_1 from x_0. If it asked for two iterations, you'd need to recompute f' at x_1 for the second step. It's easy to forget if you're doing it quickly.

- **No Convergence / Divergence:** While an exam problem likely won't have you grind out a divergent sequence, they might ask conceptually: e.g., *"Why might Newton's method fail to find the root of $f(x) = \sqrt[3]{x}$ starting at $x = 0$?"* Answer: $f'^{(x)} = \frac{1}{3\sqrt[3]{x^2}}$ which is infinite at 0, plus the function is flat there, so Newton's jumps badly. Recognize cases like: if the function is flat or nearly flat near the guess (derivative ~0), Newton's is in trouble.

- **Interpreting Results:** After one iteration, don't expect the root to be exact (unless the guess was very special). Some students might confuse the Newton update formula with an exact solution formula. It's iterative; so if they ask "after one Newton iteration, what is the estimate?", you give x_1. Don't try to solve $f(x_1) = 0$ in one step unless f is linear (in which case Newton converges in one step exactly). Also, ensure you understand the function: one iteration on a weird function might actually overshoot or go to a different root if the function has multiple roots. If the exam question is giving you this, they usually set it up so one iteration yields an obvious next guess (maybe even the answer if you only needed one iteration).

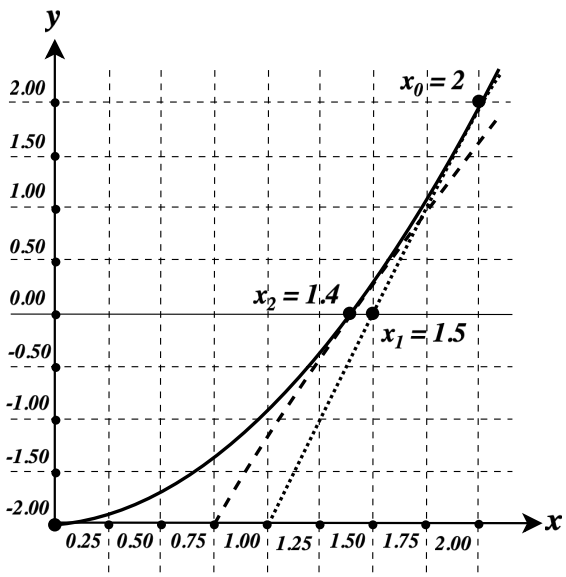

Figure: Newton's Method Iteration – Starting from an initial guess x_0, Newton's method uses the tangent line at $(x_0, f(x_0))$ to find x_1, the next guess. In the diagram, $f(x)$ is the solid curve (here $f(x) = x^2 - 2$), and we seek its root (where it crosses the x-axis). Starting at $x_0 = 2.0$, the dot indicates $f(2.0) = +2.0$. The dotted line, instead, is the tangent at $x = 2.0$, which intersects the x-axis at $x_1 \approx 1.5$. Next, we evaluate $f(1.5)$ (a much smaller value 0.25) and take the tangent there (dotted line) to find $x_2 \approx 1.4$. The method quickly homes in on the actual root $\sqrt{2} \approx 1.414$. Notice each tangent line intersection gets closer to the true root. Axes: horizontal is x, vertical is $y = f(x)$. This graphical interpretation helps explain why Newton's formula is $x_{\text{new}} = x - f(x)/f'^{(x)}$: it's literally following the linear approximation (tangent) to where $y = 0$.

Exam Handbook Search Cues (Not affiliated with or endorsed by NCEES): *Newton's method, Newton-Raphson, root finding, iteration* (In the exam reference handbook, look for "Newton's Method for Root Extraction" under the Mathematics section. The handbook outlines the formula and a note on convergence. Keywords like "root extraction" or "Newton's algorithm" will get you to the right section.)

Footnotes:

- The term *Newton–Raphson* is interchangeable with *Newton's method* – Raphson was actually an earlier contributor; Newton generalized it. Don't be confused if a question says "Use one iteration of Newton–Raphson" – it's the same method.
- **Calculator Tip:** The allowed calculators often have a solve function (for example, the TI-36X Pro has a numeric solver). Internally, they use methods like Newton's. You're free to use it on the exam to find roots, but be careful: you need a good initial guess and the correct function input. If you use the solver, double-check by plugging the root back into the equation quickly. For the purposes of understanding, though, it's good to practice Newton's method manually on a simple function to see how it behaves.
- If an exam problem gives a function and an initial guess, and asks for "the next iteration's value," just plug and crank carefully. For instance, given $f(x) = x^3 - x - 2$ and $x_0 = 1.5$, you'd compute $f(1.5)$, $f'^{(1.5)}$, then $x_1 = 1.5 - f(1.5)/f'^{(1.5)}$. This number (maybe ~1.769) would be your answer. They might round it or expect a certain number of decimals; maintain at least 3-4 sig figs through your calculation to be safe.
- **When Newton's shines:** If you ever get a chance to iterate twice, you'll see how fast it zooms in. For example, with the $x^2 - 2$ example above, starting at 2.0 → 1.5 → 1.416… by the second iteration you're accurate to ~4 decimal places. That's typical of Newton's method's speed near roots. Bisection, in contrast, would take many more iterations to get that precise (though it would never overshoot or diverge). Just an appreciation point: Newton's is usually the go-to in real engineering computing when it works.
- **Oscillation Issue:** One classic failure mode: if you apply Newton's to find the square root of a number using $f(x) = x^2 - A$, it always works great (that's a standard method for computing square roots). But if you try something like $f(x) = 1/x$ with a guess, Newton's formula becomes $x_{n+1} = x_n - (1/x_n)/(-1/x_n^2) = x_n + x_n = 2x_n$! If you guess 1, next is 2, then 4, etc., it diverges to infinity (because the function's root is at infinity in that case). So be mindful: if the function's root is at infinity or doesn't exist, Newton's will run off. Not an exam scenario likely, but interesting to note how the formula behaves.

Variations, Related Techniques, Typical Cases:

- **Secant Method:** Instead of using the derivative, the secant method uses two prior points: $x_{n+1} = x_n - f(x_n)\frac{x_n - x_{n-1}}{f(x_n) - f(x_{n-1})}$. Know that it exists as a derivative-free alternative. It converges a bit slower (order ~1.618, the golden ratio, for those curious) but still faster than bisection. If you forget the Newton formula, secant formula won't help you derive it under pressure—better memorize Newton's directly (it's also listed in the handbook for quick reference).
- **Bisection Method:** If asked about "guaranteed root bracket" or similar, that's bisection. It's simple: if $f(a)$ and $f(b)$ have opposite signs, there's at least one root in $[a, b]$. Bisection would pick the midpoint $c = (a + b)/2$, evaluate $f(c)$, and then pick the half-interval $[a, c]$ or [c,b]\] that has the sign change. Repeat until the interval is tiny. It's slow but sure. The FE might expect you to know conceptually that bisection will always converge (provided the function is continuous and the root is in initial bracket) but is not as fast as Newton's. Newton's could fail without a good initial guess, whereas bisection won't (it just won't fail, but plods along).

  - Multiple Roots: Newton's formula can be adjusted for a root of multiplicity \(m (if $f(x) = 0$ has a repeated root) by dividing by $f'^{(x)}/m$ instead, but that's beyond scope. Just note: if you apply the standard Newton to a case like $f(x) = (x - 3)^2$, you'll converge slowly because once you hit the root, $f'^{(3)} = 0$. Exam won't go into that, but they might have an answer choice "fails to converge because derivative = 0 at root" for a conceptual question.
- **Optimization (Newton's method of minimization):** This is mentioned for completeness: to find min of $h(x)$, set $h'^{(x)} = 0$ and apply Newton's to $h'^{(x)} = 0$. Formula

becomes $x_{n+1} = x_n - \frac{h'(x_n)}{h''(x_n)}$. In multiple dimensions (like optimizing a multivariable function), it becomes using the Hessian matrix etc. For FE Mechanical, detailed knowledge of that isn't required, but it ties in conceptually: Newton's method can solve equations beyond just $f(x) = 0$ if you formulate them right (like solving derivative=0 for optimization problems). If you see a control systems or vibrations question asking for the equilibrium or something, Newton's might be how you'd solve it behind the scenes, but they won't ask you to derive that on the exam – just be aware of the connection.

Explanation & Analysis (Step-by-Step): Consider a concrete example: *Solve* $x^3 + 4x - 5 = 0$ *using one iteration of Newton's method starting from* $x_0 = 1$. Here $f(x) = x^3 + 4x - 5$. First, check $f(1) = 1 + 4 - 5 = 0$. Oh! In this case, our initial guess was actually exactly a root (lucky guess, or perhaps by design). Then $x_1 = 1 - \frac{f(1)}{f'(1)} = 1 - 0/(something) = 1$. So it stays at 1. If the problem instead gave $x_0 = 0$, then $f(0) = -5, f'^{(x)} = 3x^2 + 4$, so $f'^{(0)} = 4$. Then $x_1 = 0 - (-5/4) = +1.25$. Now $f(1.25) = 1.953 + 5 - 5 = 1.953$, $f'^{(1.25)} = 3(1.25)^2 + 4 = 3 * 1.5625 + 4 = 8.6875$. Then $x_2 = 1.25 - 1.953/8.6875 \approx 1.025$. We're getting closer to the actual root ~1. (In fact, the real root is exactly 1 for this equation, which we inadvertently knew from the first scenario.) This demonstration shows how successive iterations correct the guess: from 0 too low (function was -5), jumped to 1.25 too high (function +1.95), then nudged to ~1.025 very close.

From an analytical perspective, Newton's method is essentially performing this operation: $x_{n+1} = x_n - \frac{f(x_n)}{f'(x_n)}$. This comes from the idea that the line $y = f(x_n) + f'^{(x_n)(x-x_n)}$ is tangent to f at x_n and we find where this line crosses $y = 0$. Solving $0 = f(x_n) + f'^{(x_n)(x-x_n)}$ for x yields the update formula. This geometric picture (as described in the figure above) explains both why Newton's works fast (if the tangent is a good local linear approximation, we jump directly toward the root) and why it can fail (if the tangent is horizontal or takes us to a weird region, the jump isn't helpful).

One more thing: the exam might phrase a question in terms of "fixed-point iteration" or "convergence criteria." Newton's method is one type of fixed-point iteration $x_{n+1} = g(x_n)$ where $g(x) = x - f(x)/f'^{(x)}$. Fixed-point theory says it converges if |g'(x)|<1 near the root. For Newton, $g'^{(x)} = 0 - \left[f'^{(x)}f'^{(x)} - f(x)f''^{(x)}\right]/\left[f'^{(x)}\right]^2$ which at the root simplifies to 0 (for a simple root), hence the fast convergence. You likely won't need to delve into that on the FE, but it's nice to know that Newton's method essentially solves $g(x) = x$ for a cleverly chosen g.

Finally, always keep an eye on the practicality: Newton's method in a calculator can solve many equations quickly if you know how to use it, but the FE wants you to grasp the concept. If a problem asks for one iteration, do just that and stop—don't try to iterate to final answer unless explicitly asked. If it asks conceptually, mention things like speed, needing derivative, possible divergence. This subtopic, in essence, ensures you are comfortable with the idea of an algorithm improving an answer iteratively rather than a closed-form solution. In engineering, that's often how we tackle real-world equations.

Topic 06 - Algorithm and Logic Development

Topic Intro: Algorithm and Logic Development covers the fundamental structures that underlie all computer programs and automated processes. In the context of the **FE Mechanical Exam**, this topic isn't about writing actual code – it's about understanding the *logic* of a sequence of steps. You'll encounter questions where a small **flowchart** or **pseudocode** snippet is presented, and you must deduce what it does or what result it produces. These questions test your ability to think methodically, follow logical steps, and catch common pitfalls (like misordered operations or loop errors). By mastering this chapter, you'll be ready to tackle those logic problems efficiently on exam day, without getting tripped up by programming-like syntax. Remember, even if you've never coded before, you use algorithms every day – from following a recipe to sorting tools in a toolbox. This chapter will show you how to recognize and work with those same logical patterns under exam conditions.

K01.T06.S01 – Algorithm Building Blocks (Sequence, Selection, Iteration) & Flowcharts

Principle Introduction: Every algorithm, no matter how complex, is built from just three basic control structures: **sequence**, **selection**, and **iteration**. These are the "building blocks" of logic development, and understanding them is key to reading and designing algorithms:

- **Sequence:** The default behavior of executing instructions one after another in a given order. In sequence, each step follows the previous in a straight line. For example, calculating a value, then printing it, is a sequence of two steps. Order matters – swapping the order of steps can change outcomes. Most lines of pseudocode or flowchart actions are part of a sequential flow unless a special control redirects them.
- **Selection (Decision/Branching):** A point in the algorithm where a **condition** is evaluated and a choice is made. If the condition is true, one set of steps is executed; if false, an alternative set (or none) is executed. This is typically represented by an **if…then…else** structure in pseudocode. Selection allows the algorithm to **branch** into different paths. For example, "if temperature is above setpoint, turn off heater; else keep it on" is a selection logic. In flowcharts, this appears as a **diamond** shape (decision node) with two outgoing arrows (Yes/No or True/False).
- **Iteration (Looping):** A structure that repeats a block of steps multiple times. The loop continues **iterating** until a certain condition is met, or it repeats for a fixed count. Common loops include **for** loops (repeat a set number of times) and **while** loops (repeat while a condition is true). Iteration is how algorithms handle repetitive tasks without rewriting steps. For example, summing all numbers from 1 to 100 can be done with a loop that adds each number in turn. In flowcharts, loops are depicted by arrows that **cycle back** to an earlier step (often back to a decision diamond to check if the loop should continue).
- **Flowcharts:** A **flowchart** is a visual diagram that maps out an algorithm's flow using standardized symbols. The main symbols are: **oval** for Start/End, **rectangle** for a Process (a step or calculation), **diamond** for a Decision (a yes/no question or test), and **parallelogram** for Input/Output operations. Arrows connect these symbols, showing the direction of execution flow. Flowcharts are great for visualizing how an algorithm progresses from start to finish, how it branches on decisions, and how it loops. They provide an "at-a-glance" understanding of the overall logic structure.

  On the FE exam, you might see a simple flowchart and need to interpret its logic or outcome, so recognizing these symbols and following the arrows step-by-step is essential.

Visual: Below is an example flowchart that illustrates all three building blocks (sequence, selection, iteration). This diagram represents a simple algorithm: it initializes a sum, then uses a loop to add numbers from 1 through 5. The decision diamond checks the loop condition ($i \leq 5$), creating an iterative cycle, and uses selection (the condition's true/false branches) to either continue the loop or exit it. The sequential steps inside the loop update the sum and the counter i. Together, this flowchart showcases a **sequence** of operations, a **selection** at the decision, and an **iteration** via the loop back to the decision node.

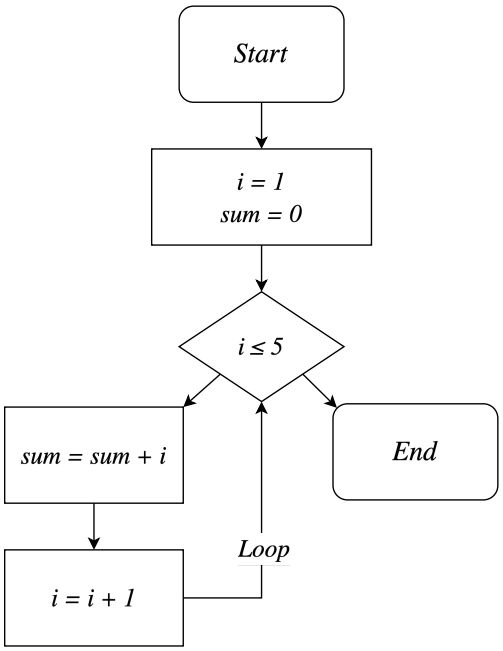

Example flowchart: This flowchart computes the sum of integers from 1 to 5. It starts by initializing i = 1 and sum = 0 (sequence). Then a decision checks $i \leq 5$ (selection). If true ("Yes"), the algorithm executes the loop body: add i to sum, increment i (sequence of two steps inside the loop), and then loops back to re-check the condition (iteration). When the condition becomes false ("No"), the loop stops and the algorithm proceeds to the End. This visual layout shows how sequence, selection (the diamond decision with two branches), and iteration (the arrow looping back) work together in a simple algorithm.

Exam Handbook Search Cues (Not affiliated with or endorsed by NCEES): *algorithm*; *flowchart*; *sequence*; *decision*; *loop*; *iteration*; *if-then*. *(These are keywords you might use to search the exam handbook for quick reference on algorithm logic. The exam handbook includes basic definitions of algorithms and may list pseudocode conventions – use these terms to find those reference points during the exam.)*

Footnotes:

- *Loop vs. Recursion:* All repetitive logic on the FE is typically handled with loops (iteration). Recursion (functions calling themselves) is another way to repeat in computer science, but it's beyond our scope here and not generally tested on the FE Mechanical exam.

- *Structured Programming:* A famous result in computer science says any algorithm can be built using just sequence, selection, and iteration. This means whenever you read a complex algorithm, you can break it down into these basic pieces – a helpful thought if you feel overwhelmed by a logic problem.

- *Flowchart clarity:* Flowcharts in exam questions are usually simple and clear. You won't need to draw them, just read them. Follow the arrows with your finger or pencil if needed – it's like following a road map from "Start" to "End." Ensure you take the correct branch at each decision diamond (based on the condition given).

Variations and Related Forms: Each of the control structures has some variations in how they might appear:

- **Selection variations:** Besides basic if…then…else, some pseudocode or flowcharts might use **multiple-selection** (e.g., nested if statements or a switch/case structure) to choose between more than two paths. The concept is the same – each condition directs the flow down a different path. Make sure you identify the condition and which branch is taken for the given scenario.

- **Iteration variations:** Common loop types include for loops (repeat for a set number of iterations, often used when you know how many times to loop) and while loops (repeat until a condition becomes false). Another variant is do…while (or "repeat…until"), which checks the loop condition at the **end** of the loop instead of the beginning, guaranteeing the loop runs at least once. No matter the type, all loops have the same logic: they repeat a block of code, and they need a stopping condition. On the exam, be ready to interpret any loop construct. For example, a for loop like "for k = 1 to 10" clearly runs 10 times; a while loop runs unknown times until its condition fails. If a loop doesn't modify the condition properly, it can lead to an **infinite loop** (which in a flowchart would look like an arrow that keeps cycling with no exit) – typically an error to be avoided.

- **Flowchart variations:** Not every flowchart will show every symbol. Some may omit explicit *Start* or *End* ovals if the context is clear. Input/Output (I/O) steps might appear if the algorithm reads or prints a value (parallelogram symbol), but many exam scenarios hard-code a starting value or just ask for final output. Each shape's role remains standard: oval for start/end, rectangle for process, diamond for decision. Sometimes connectors or subroutine symbols appear in more complex charts, but the FE exam tends to keep it straightforward.

Special Notes: You won't need a calculator for algorithm questions – these are pure logic problems. However, *you might need to do some quick arithmetic* as you simulate an algorithm's steps with actual numbers. Be comfortable doing simple additions, multiplications, or comparisons by hand so you can follow the algorithm's effect on variables. Also, be mindful of **pseudo-syntax**: the exam's pseudocode (covered in the next subtopic) has its own conventions (like using = for assignment). If you're used to another programming language, adjust to the pseudocode style given so you don't misinterpret anything.

Explanation: An **algorithm** is basically a *recipe* or *procedure* for solving a problem. In an algorithm, **sequence** is like the ordered steps in a recipe: first do A, then B, then C. **Selection** is like a decision point in the recipe: "if the sauce is too thick, add water; otherwise, do nothing" – you choose a path based on a condition. **Iteration** is like telling someone "stir the mixture for 5 minutes" or "keep adding spices until it tastes right" – it implies repetition. These concepts matter in engineering computations and decision-making. For instance, a program might check a sensor reading and decide (selection) to activate a cooling fan if the temperature is above a setpoint, and it might do this check repeatedly in a loop (iteration) so that the control is continuous over time. On the FE Mechanical Exam, you might not be programming a controller, but you *could* be given a simplified flowchart of such logic and asked something like: *"After 3 cycles, what is the value of X?"* or *"Which of the following best describes what this flowchart accomplishes?"* Knowing these building blocks ensures you can break down the logic: follow the sequence of steps in order, take the correct branch at each decision, and repeat the loop as directed.

When you see a **flowchart** on the exam, approach it systematically:

- **Start at the Start:** Identify the *Start* oval and follow the arrow to the first step. - **One Step at a Time:** Execute each rectangle (process) in order. These usually involve assigning a value to a variable or performing a calculation.

- **Follow Decision Branches:** When you reach a diamond (decision), carefully evaluate the condition given (e.g., "**Is i ≤ 5?**" or "**Is Pressure > P_max?**"). Determine which branch (Yes/True or No/False) applies to the situation in the question. The flowchart might label the branches, or use convention (typically the right or downward arrow is "yes/true" and the other is "no/false", but always read any labels or context).

- **Loop if indicated:** If an arrow cycles back to a previous step or decision, you've encountered iteration. Understand what condition causes the loop to continue or terminate. You may have to simulate the loop's effect multiple times. For example, in the flowchart above, as long as $i \leq 5$ is true, you keep looping. Each loop iteration changes i (increasing it) and perhaps other variables, eventually making the condition false so you can exit.

- **Track Variables:** It's crucial to keep track of how variables change. Many students find it helpful to jot down a quick table of variable values for each iteration, especially if asked for a final result after the loop. This *hand-tracing* technique ensures you don't lose track of a variable's latest value or confuse one loop cycle with another.

- **End at the End:** Once you follow the logic to the *End* oval, you should have a clear picture of what the algorithm did. If the question asks for an output or final value, that should have been determined by the last step before End.

Analysis (Step-by-Step Example): Let's apply these ideas to a concrete example to solidify them. Imagine a flowchart (or pseudocode) that implements a simple task: **checking a list of numbers and finding the largest one**. This is a classic algorithmic

problem, and it uses all our building blocks. We'll outline the logic and then simulate it:

- **Problem:** Find the maximum value in a list of five numbers.
- **Algorithm (in plain steps):**
- Start.
- **Initialize** a variable max_val with a very small number or the first element of the list (sequence).
- **Loop** through each number in the list (iteration). For each number, do step 4.
- **If** the current number is greater than max_val **then** replace max_val with the current number (selection inside the loop).
- End Loop when all numbers have been checked.
- The value in max_val is the result – the largest number. End.

In pseudocode form, that might look like:

```
max_val = first number in the list
for each num in list do
   if num > max_val then
      max_val = num
   end if
end for
// max_val now holds the largest value
```

In a flowchart, this would be a loop that goes through each element, with a decision comparing each element to the current max.

- **Step-by-step trace:** Suppose our list of numbers is [3, 8, 2, 10, 6]. We walk through the algorithm:
- Start: max_val is set to 3 (the first number).
- Loop starts. **Iteration 1:** current num = 3. Check if num > max_val → that is if 3 > 3. This is false (3 is not greater than 3), so we do nothing in the if. max_val stays 3. Loop moves to next item.
- **Iteration 2:** num = 8. Check if 8 > max_val (max_val is 3). Condition true (8 > 3), so inside the if: set max_val = 8. Now max_val is 8. Continue loop.
- **Iteration 3:** num = 2. Check if 2 > max_val (max_val is 8). 2 > 8 is false, so no change. max_val remains 8.
- **Iteration 4:** num = 10. Check 10 > 8 → true, so update max_val = 10. Now max_val is 10.
- **Iteration 5:** num = 6. Check 6 > 10 → false, no change. max_val stays 10. Loop ends (we've gone through all items).
- End: The algorithm would output or return max_val, which is 10, correctly identifying the largest number.

Throughout this process, we used **sequence** (setting initial max_val, updating it), **selection** (the if check each time), and **iteration** (the loop over each number). If this were an exam question, we might be asked: "What is the value of max_val after this algorithm runs on the list [3, 8, 2, 10, 6]?" By tracing systematically as we did, we'd arrive at 10.

A key observation is how critical *each building block* was: - Missing or messing up the **sequence** (e.g., not resetting max_val correctly at start) would produce a wrong result. - Mistaking the **selection** condition (using a wrong comparison like < instead of >, or updating when you shouldn't) would also yield an incorrect max. - Errors in **iteration** (like not looping through all items, or looping one time too many or too few) could skip the true maximum or compare an extra uninitialized value.

Thus, careful attention to each part of the logic is needed. On exam day, **take your time stepping through the logic**. It's easy to make a slip in a rush (for example, thinking 2 > 8 was true, or forgetting to update a variable). A disciplined, step-by-step approach – just like we did – will catch these mistakes. If the logic is simple, you can often do it mentally, but for safety, jotting down a quick table of variables for each iteration (a *trace table*) can be a lifesaver for complex loops. This prevents confusion, especially under exam pressure. Remember, the exam isn't testing your ability to write code from scratch, but rather your ability to **interpret and follow** a given algorithm. Practice a few by hand, and you'll gain speed and confidence.

K01.T06.S02 – Pseudocode Writing and Interpretation for Program Logic

Principle Introduction: *Pseudocode* is a method of writing down an algorithm in a way that resembles a programming language, but is not tied to any specific language's syntax. It's a mix of plain English and code-like structuring that allows you to focus on the **logic** rather than the details of syntax. In other words, pseudocode is **"fake code"** – it's not meant to be compiled or run by a computer, but it's written to be easily read and understood by humans. On the FE Mechanical Exam, pseudocode is used to describe algorithms in a clear, standardized way. You might be asked to read a pseudocode snippet and determine what it does, what a certain output will be, or even which line contains an error. Being comfortable with pseudocode is important because it's the bridge between a flowchart (visual) and actual code (which has strict syntax). Here are key points about pseudocode and why it matters:

- **Writing Pseudocode:** When writing pseudocode, we use common programming constructs (like if/then, loops, assignments) but we don't worry about language-specific characters or precision. For example, you wouldn't include a semicolon at the end of a line (as some languages do), nor would you need to declare detailed data types or include library headers. The goal is to write the steps clearly and unambiguously. Everyone might write pseudocode a bit differently, but the FE exam will follow a consistent style (outlined in the exam handbook) so that you can recognize structures easily. We'll highlight those conventions shortly.
- **Interpreting Pseudocode:** To interpret pseudocode means to read it and understand the algorithm it represents. This involves recognizing the control structures (sequence, selection, iteration from the previous subtopic) now written in a textual form. You should be able to follow the pseudocode line by line, just as you would trace through a flowchart. The challenge some examinees face is getting tripped up by unfamiliar notation or ignoring a subtle detail (like a loop's starting index or an update step). By learning the pseudocode format and practicing reading it, you'll be prepared to quickly grasp what any given snippet is doing. Think of pseudocode as simply *instructions in structured English* – you can read them like reading a recipe or set of directions.
- **Exam Relevance:** In the FE Mechanical exam, pseudocode questions typically present a short piece of pseudocode (maybe 5-15 lines) and then ask something about it: e.g., *"What is the output of this program given*

an input X?", *"How many times will the loop execute?"*, or *"Which of the following best describes what this pseudocode calculates?"*. Less often, you might be asked to fill in a blank or identify a correction in a piece of pseudocode. Being prepared means you know how to identify the parts (initializations, loops, conditionals) and you can perform a mental or written trace to arrive at the answer confidently.

- **Pseudocode vs. Real Code:** The benefit of pseudocode is that it's **not picky** about exact syntax; it's meant to be easily understood by anyone with basic programming knowledge. For instance, whether you come from a background in C, Python, or no coding at all, pseudocode is intended to be approachable. It uses simple keywords and structure. However, because it's not an actual programming language, you should focus on **what it does**, not whether it would compile. There are no trick syntax errors or obscure language-specific functions on the FE, if something looks like a mistake in pseudocode, it's likely part of the question (for example, asking what's wrong in the logic, not in the syntax). So don't overthink the format; instead, concentrate on the logic being conveyed.

Pseudocode Conventions (Exam aligned): To keep our examples consistent, this book adopts a simple, language-neutral pseudocode style. It's similar to what you may have seen in many programming textbooks and is meant purely as a teaching convention here. Treat the conventions below as a convenient style for practicing logic.

- **General format:** The pseudocode is written in plain text, using indentation or end statements to show structure. There are **no curly braces {}** or other language-specific delimiters, and **no end-of-line punctuation** like semicolons ; . Each step is usually on a new line.
- **Comments:** If you see a double hyphen --, everything following it on that line is a comment (explanatory note) and not executed. For example:
  total = 0 -- initialize total to zero
  The part after -- is just a comment to help the reader, not an actual operation.
- **Assignments vs. Comparisons:** An **assignment** (setting a variable's value) uses a single equals sign. For instance, count = 0 means "set count to 0". A **comparison for equality** in a condition uses a double equals == or sometimes a phrasing like if x equals y. But typically, == is used in conditions. So:

  ```
  if count == 0 then
     ...
  end if
  ```

  checks if count is zero, whereas count = 0 would set it to zero. **Be very mindful** of this difference! A common mistake is to confuse = and ==. Remember: in pseudocode, = means assignment, and you'll usually only see == in the context of an if or loop condition checking equality.
- **Inequalities:** Not equal is written as <> in pseudocode (this is a math-style notation, read as "not equal to"). For example: if temperature <> 100 then ... means "if temperature is not equal to 100, then ...". Other comparisons use the usual symbols like <, >, <= (written as ≤ in math, but pseudocode may use <=), and >=. These work as expected for conditions.
- **Logical operators:** AND and OR in conditions are written out as words: and, or (instead of symbols like && or ||). Example: if A > 0 and B > 0 then ... means both conditions must be true.
- **If-Then structure:** An if condition in pseudocode will typically be written with the **then** keyword included for clarity, and an explicit **end if** to mark where the conditional block stops. For example:

  ```
  if x < 0 then
     print "Negative"
  else
     print "Non-negative"
  end if
  ```

  This shows an if/else. Notice end if at the end. Also note that if there's an else if (to check another condition if the first was false), it often is used instead of ending and starting a new if. For instance:

  ```
  if score >= 90 then
     grade = "A"
  else if score >= 80 then
     grade = "B"
  else
     grade = "C"
  end if
  ```

  Here else if continues the structure without needing an end if until the very end of the whole chain. Indentation is usually used to show what's inside the if or else, which makes it easier to read.
- **Loop structures:** Loops will also explicitly end. A while loop will end with an end while. For example:

  ```
  i = 1
  while i <= 5 do
     sum = sum + i
     i = i + 1
  end while
  ```

  This loop continues while the condition holds, and you see end while to signify the loop's closing point. A for loop might use end for similarly. Sometimes pseudocode uses a shorthand like for i = 1 to 5 do ... end for. Both mean the same thing.
- **"Do-While" loop:** One slightly different case is the *do-while* loop (also called *repeat-until* in some texts). In this guide's pseudocode style, a do-while loop is written starting with do and then the loop body, and it ends with a while ... condition at the bottom (instead of an end do). For example:

  ```
  do
     x = get_sensor_reading()
  while x < 0
  ```

  This means "do the action at least once, and then if x < 0, repeat the loop". There's no separate end do; the while ... serves to both check and loop back. It's a minor detail, but keep in mind so you're not confused if you see a loop where the condition appears at the end rather than the top.
- **Syntactic style:** Variable names and such may be written with a colon for type when relevant. For instance, a function definition might appear as function

computeArea(radius: float) -> float indicating the parameter and return types. But within algorithm steps, you generally won't need to worry about data types unless it's relevant to the logic. Numbers are numbers, and if something needs to be an integer, it'll be clear from context. The exam won't, for example, trick you with integer division vs floating point—unless that's explicitly part of the problem.

- **No specific language syntax:** You won't see tricky syntax like i++ or += or the ?: operator etc. If something is incrementing, it will likely be spelled out as i = i + 1. If a piece of pseudocode needs to swap two variables, it might use a temporary variable openly. The style is kept simple and clear to avoid confusion. Focus on the logic rather than any shorthand.

These are the conventions we'll follow in this book's pseudocode. On the real exam, always refer to the official FE Reference Handbook for the precise pseudocode syntax used in questions.

Learning these conventions, you might notice they resemble languages like Ada, Pascal, or just a very structured form of plain English. The key takeaway is that **pseudocode on the FE exam is standardized** – once you learn the handful of rules above, you can parse any pseudocode they throw at you. And you do **not** need to write pseudocode from scratch on the exam (there are no open-ended coding questions); you only need to read/understand it. However, when solving problems yourself, you can *use* pseudocode as a tool: for instance, when planning how to solve a more complex problem, writing pseudocode on your scratch paper can organize your thoughts.

Exam Handbook Search Cues (Not affiliated with or endorsed by NCEES): *pseudocode*; *algorithm*; *loop*; *if then*; *end while*; *do while*. *(These keywords correspond to how the exam handbook references pseudocode conventions and logic structures. For example, searching "pseudocode" or "while" in the digital handbook on exam day can quickly bring up the guidelines if you need to double-check how a loop or conditional is structured.)*

Footnotes:

- *Beware of Off-by-One:* One of the most common logical mistakes (by students and even professionals) is the **off-by-one error** in loops. This happens when a loop runs one time too many or one time too few. For example, iterating for i = 1 to N will execute the loop N times (for i = 1, 2, ..., N). But if someone writes for i = 1 to N-1 thinking it's N times, that's actually N-1 iterations. Or confusing a <= with < in a while condition can alter how many times it runs. Always double-check the loop boundaries.

- *Uninitialized Variables:* In pseudocode, if you see a variable being used that hasn't been set yet, that's a red flag. A well-written algorithm will initialize its variables before using them (e.g., sum = 0 before adding to sum). If an exam question has a bug or asks for a fix, an uninitialized variable is a likely culprit – it's like starting a calculation without a starting value.

- *Indentation & Formatting:* The exam pseudocode typically uses indentation to make the structure clearer (each level of nested logic is indented a few spaces). While you won't need to reproduce that formatting in your answer, **use it to your advantage** while reading. It visually groups which statements belong together. If an if or loop isn't indented, that's a hint it might be outside the structure you think it's in.

- *No Calculator Needed:* Just as with flowcharts, pseudocode problems usually don't require heavy calculation. If numbers are involved, they'll be small enough to handle mentally or with one or two quick operations on scrap paper. The focus is on logic, not arithmetic complexity.

Explanation: Think of pseudocode as the *written narrative* of an algorithm. If a flowchart is a picture, pseudocode is the story explaining that picture. To effectively use pseudocode on the exam, approach it like reading a set of **step-by-step instructions**:

1. **Identify the structure:** Skim the pseudocode and recognize the blocks – where does the if start and end? Where is the loop? Mark in your mind (or lightly on scratch) the segments for initialization, processing, decision, etc. This quick outline prevents you from getting lost in the details.

2. **Understand the goal:** Often, if you read pseudocode from top to bottom in plain language, you get a sense of what it's doing. For example, you might paraphrase: "Okay, it starts by setting total = 0. Then it loops from 1 to N, adding each number to total. Finally, it prints total. Ah, so it's summing the first N numbers." Doing this kind of translation to plain English is a powerful technique – it's like explaining the code to yourself, which clarifies any confusing parts.

3. **Trace with simple inputs:** If the question asks for an output or result, the safest strategy is to **trace the pseudocode with the given input** (or pick a simple one if none is explicitly given). Let's say the pseudocode calculates something for an input N = 5. You would simulate it: go through each line, and keep track of variable values just as we did in the flowchart example earlier. Write down N = 5; total = 0 initially. Then each loop iteration, update total and maybe note the loop index. By the end, you'll have the final total. This is essentially performing the computation by hand, and it guarantees you the correct result that the pseudocode would produce.

4. **Check conditions carefully:** When you come across an if or a loop condition, evaluate it exactly as written. For instance, if the pseudocode says while (x < 100) do ... end while, and x is increasing by 5 each loop, figure out: when will x < 100 stop being true? If x starts at 0, the loop runs while x = 0, 5, 10, ..., 95 (since 100 is the first time it's *not* < 100). That's 20 iterations (from 0 to 95 step 5 is 20 steps). Off-by-one errors happen when we mis-evaluate that endpoint. So double-check by maybe doing one more loop than you think and seeing if the condition would still hold. This careful attention avoids mistakes like thinking it runs 19 times or 21 times.

5. **Mind the edges:** Pay special attention to the beginning and end of loops (first and last iteration) and both branches of any if/else. Most logic bugs or tricky exam questions revolve around these "edge cases." For example, if a pseudocode has an if/else but no action in the else, what happens in that case? Or if a loop runs zero times (because the initial condition was false), is the result still well-defined (was there an initialization that covers that)? Ask yourself these questions as you read through – it's what the exam might be implicitly testing.

Let's illustrate interpretation with a short pseudocode example and then analyze it step by step:

Example: Suppose we have the following pseudocode snippet (annotated with line numbers for reference):

```
1.  function mystery(n: integer) -> integer
2.      result = 0
3.      for i = 1 to n do
4.          if (i mod 2 == 0) then
5.              result = result + i
6.          end if
7.      end for
8.      return result
9.  end function
```

First, note what this code is doing: - Line 2 initializes result to 0. - Lines 3–7 describe a loop: "for i = 1 to n". - Inside that loop, line 4 checks if (i mod 2 == 0). The operator mod typically means modulus (remainder), so this condition is "if i is divisible by 2 (i.e., i is even)". If the condition is true, line 5 executes: result = result + i (add the current i to result). If the condition is false (i is odd), line 5 is skipped. - After the loop ends, line 8 returns result.

In plainer terms, this function mystery(n) is summing up all even numbers from 1 to n. (We can deduce that logically: it adds i to result only if i is even.)

Now, let's **analyze it step-by-step** for a specific input to be sure. If the question were, for example, "What is the value of mystery(5)?", we'd plug in n = 5 and simulate: - Initially, result = 0. - The loop will run with i taking values 1, 2, 3, 4, 5 (from 1 to n inclusive). - For i = 1: Check 1 mod 2 == 0. Since 1 mod 2 is 1 (not 0), the condition is false. So we skip the addition. result stays 0. - For i = 2: Check 2 mod 2 == 0. 2 mod 2 is 0, condition true. So execute result = result + 2. That changes result from 0 to 2. - For i = 3: 3 mod 2 is 1, not 0, condition false. No change; result remains 2. - For i = 4: 4 mod 2 is 0, condition true. Execute result = result + 4. result was 2, now becomes 6. - For i = 5: 5 mod 2 is 1, false condition. No change; result stays 6. - Loop ends. The function returns result, which is 6.

So mystery(5) would output 6. And indeed, the even numbers from 1 to 5 are 2 and 4, which sum to 6 – the logic checks out.

If the exam asked, "The given pseudocode defines function mystery. What is mystery(5)?", we can confidently answer 6 after this analysis. If it asked more conceptually, "What does this function compute in general?", we'd say "It returns the sum of all even integers from 1 up to n."

Notice a few things in that example: - We used the pseudocode conventions: the for loop goes 1 to n inclusive, the if uses == for comparison, and mod is a mathematical operation (not a special symbol like % in some languages, but given in an easily understood form). - We traced through each iteration systematically. This is important – skipping mental steps can lead to mistakes. By writing it out (especially under exam pressure), we ensured we didn't, for instance, mistakenly add an odd number. - We interpreted the *purpose* after we did the detailed work, which is a good check. If you can summarize what the pseudocode does in one sentence and that makes sense, you likely understood it correctly.

For the FE exam, you typically won't have to write pseudocode, but understanding how to could indirectly help you. For instance, if a question poses a problem scenario (not in code) and you're stuck, you might sketch a quick pseudocode on scratch paper to structure your solution. It's a tool to organize thoughts logically.

Analysis Tip: Use the **Trace Table method** for complex pseudocode. Draw columns for each important variable and perhaps the loop index, and update their values row by row as you simulate the code. This is especially useful if the pseudocode has nested loops or multiple variables changing. It converts the abstract code into a concrete table of values you can examine. Many students find that any confusing logic bug or tricky condition becomes obvious when they see the numbers laid out.

Finally, keep an eye out for **common traps** in pseudocode questions: - Sometimes a question might include a line that *appears* to do nothing or is never reached, and the question asks about it. For example, code after a return in a function would never execute, or a variable that gets assigned but not used. Don't let those distract you; recognize what actually affects the outcome. - Watch for integer division versus float division if it ever comes up (e.g., if the pseudocode does result = a / b and a and b are integers, is the intention to drop fractions or not?). The exam usually avoids ambiguity there, but be aware of context. If they intended an integer division, they might show something like // or explicitly mention it. If not, assume normal math unless told otherwise. - Pay attention to initial values and final outputs. If a loop accumulates a result, check that the initial value makes sense (0 for sum, 1 for product, etc.). If it doesn't, that might be the point of the question (maybe they set a wrong initial value and ask what effect that has). - Don't confuse yourself with unnecessary assumptions. Pseudocode might use slightly different words than you expect (like enqueue instead of push for adding to a queue, etc.), but they'll either explain it or the meaning can be inferred. Focus on the logic relationships, not the exact wording.

To sum up, interpreting pseudocode is a skill of *reading comprehension* applied to a logical recipe. Practice a few, and you'll start seeing the patterns: initialization, loop, condition, update, output. After all, it's the same set of building blocks (sequence, selection, iteration) dressed up in text form. In fact, whenever you get a pseudocode question, you can mentally map it to a flowchart or just to the conceptual blocks: this helps ensure you haven't missed anything. You're now equipped with the knowledge of how pseudocode is structured and how to systematically break it down. Next, we'll summarize the key takeaways from this topic for quick review.

DON'T MOVE ON YET!

Work Through Some Solid Practice Problems
while the Material of this Knowledge Is Still Fresh
THIS IS HOW THE CONCEPTS LOCK IN.

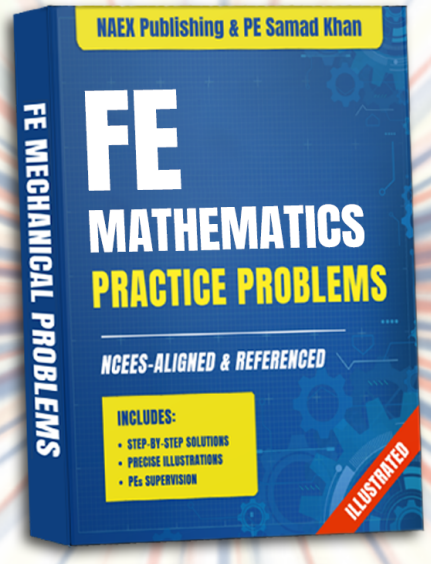

CLICK HERE TO PRACTICE

You'll be taken to our Discord Server, where the problems are located.

KNOWLEDGE 02

PROBABILITY & STATISTICS

- NAEX Publishing -

"This publication is not affiliated with or endorsed by NCEES".

Topic 01 - Probability Distributions

Topic Introduction: Probability distributions describe how likely different outcomes are for a random variable. On the **FE Mechanical Exam**, you'll encounter questions where you must identify the appropriate distribution for a scenario and use its formula to find probabilities or expected values. For example, you might be asked to compute the probability of a certain number of successes (→ think *binomial distribution*) or to find the likelihood of a measurement falling within a range (→ often *normal distribution*). Mastering this topic means you can quickly recognize **discrete vs. continuous** cases, recall key distribution formulas, and plug in values confidently under exam pressure. The typical question archetype here is a word problem describing a random process (like machine part failures, quality control tests, or measurement errors) and asking for a probability or threshold – you solve it by choosing the right distribution formula and applying it with the given parameters. This chapter will build your intuition and speed in handling these distribution scenarios, which is crucial for efficient problem-solving on exam day.

K02.T01.S01 – Fundamental Probability Distribution Functions (Discrete & Continuous)

Principle Introduction – Subtopic Background: Probability distribution functions come in two flavors depending on the type of random variable: **discrete** (only specific values) and **continuous** (any value in a range). Key ideas include:

- **Discrete distributions** use a **Probability Mass Function (PMF)** – it gives the probability for each possible outcome. For a discrete random variable X that can take values $x_1, x_2, \dots, x_n$, the PMF is $f(x_k) = P(X = x_k)$. Each individual probability is between 0 and 1, and the sum of all probabilities is 1.
- **Continuous distributions** use a **Probability Density Function (PDF)** – it gives a density over outcomes. A continuous random variable can take infinitely many values, so we assign probabilities to ranges of values. The PDF $f(x)$ is nonnegative and integrates to 1 over its domain. Crucially, for continuous variables $P(X = x)$ at any exact point is *zero* – only intervals have nonzero probability.
- **Cumulative Distribution Function (CDF)** – for *either* discrete or continuous cases – is defined as $F(x) = P(X \leq x)$. It accumulates probability from the left up to a point x. The CDF starts at 0 for very low values and approaches 1 for high values, providing an alternative way to describe the distribution.
- Knowing whether a problem deals with a discrete or continuous variable is the first step: discrete outcomes (like counts of events or successes) imply summing probabilities (PMF); continuous outcomes (like dimensions, time, or any measured quantity) imply integrating a density (PDF) or using the CDF directly for probability calculations.

Exam Handbook Search Cues (Not affiliated with or endorsed by NCEES): probability mass function; probability density function; cumulative distribution function; discrete vs. continuous

Footnotes: - *Notation:* It's common to use lowercase $f(x)$ for a PMF or PDF and uppercase $F(x)$ for the CDF. Be mindful of context – $f(x)$ in a discrete context gives a direct probability, while $f(x)$ in a continuous context must be integrated over an interval to get a probability. - *Normalization:* Any valid PMF or PDF must sum/integrate to 1 over all possible values – this reflects 100% probability total. On the exam, if you're given a function and asked if it's a valid distribution, check that this normalization condition holds. - *Scope:* **Discrete distributions** usually model counts (e.g. number of defective parts, count of occurrences) and assume individual outcomes have nonzero probability. **Continuous distributions** model measurements (e.g. lengths, time to failure) with an underlying continuum of values. Recognizing which scenario you have will guide you to the right formula. - *Assumptions:* We assume the random variable's outcomes cover the full range of interest and that probabilities are defined properly. For continuous cases, functions are nice enough to integrate (no pathological cases on the FE Exam).

Variations & Related Forms: - The **CDF** can be used to compute probabilities in either case: for discrete $P(X \leq x) = \sum_{x_k \leq x} P(X = x_k)$, for continuous $P(X \leq x) = \int_{-\infty}^{x} f(t)\,dt$. Also, for continuous distributions, differentiating the CDF yields the PDF: $f(x) = \frac{d}{dx}F(x)$. This means if you're given a cumulative distribution (perhaps piecewise), you can find the density by differentiation – a move that occasionally pops up in exam problems.

- **Support (domain):** The range where the random variable can lie. For discrete distributions it's the list of possible values (e.g. 0, 1, 2, … for a count variable); for continuous, it could be an interval $[a, b]$ or $[0, \infty)$ or the whole real line. Always consider the support when calculating probabilities (e.g. don't integrate a PDF beyond where it's defined).

- **"At least / at most" interpretation:** If a question asks $P(X \geq a)$ or similar, it's often easier to use the CDF: $P(X \geq a) = 1 - F(a^-)$ (continuous) or $1 - F(a - 1)$ (discrete, using the step just below a). In practice, for discrete variables "at least a" means sum from a to max; for continuous, do $1 - F(a)$. This is a common need on the exam, e.g., "at least 3 successes" means sum probabilities for 3, 4, …, n, or use 1 minus cumulative up to 2.

– **Expectation formulas:** (While the details of expected value are covered under statistical measures elsewhere,) note that given a PMF or PDF, the mean $E[X]$ can be found by $\sum x_k P(X = x_k)$ (discrete) or $\int_{-\infty}^{\infty} x\, f(x) dx$ (continuous). This connection might help solve problems where you're effectively computing an expectation by summing or integrating $x \times$ (probability) – often disguised in exam questions asking for an average outcome given a distribution. *(We'll formally address means and variances in another chapter, but keep this relation in mind.)*

Explanation & Analysis:

A **probability distribution function** is the core tool for handling randomness. It tells you how the total probability 1 is distributed across outcomes. If you have a **discrete random variable** X (say, the number of defective items in a batch), you list out each possible outcome and its probability. For example, if X can be 0, 1, or 2 defects, a valid PMF could be something like $P(X = 0) = 0.7$, $P(X = 1) = 0.2$, $P(X = 2) = 0.1$. You can directly use these probabilities to answer questions like "What is the probability of exactly 1 defect?" (that would be 0.2). If you need "at most 1

defect," you add up 0 or 1: $0.7 + 0.2 = 0.9$. **Tip:** For any discrete distribution, double-check that all given probabilities add up to 1 – if not, something's wrong (either a trick in the question or a normalization you need to do).

For a **continuous random variable** (say, the diameter of a bolt coming off a production line, measured in mm), outcomes aren't isolated points but a continuum. Here, the PDF $f(x)$ doesn't give direct probabilities for exact values – instead, probability comes from *areas* under the curve of $f(x)$. For instance, if $f(x)$ is a uniform density between 19 mm and 21 mm, then $P(19.5 < X < 20) = \int_{19.5}^{20} f(x)dx$. You'd calculate this area to find the probability. A common mistake is trying to plug into a continuous $f(x)$ as if it were a direct probability – **don't do that**. Always integrate (or use the CDF difference) for continuous probabilities. One sanity check: as interval length shrinks to 0, probability should go to 0 as well; that's why $P(X = \text{exact value}) = 0$ in continuous cases.

The **cumulative distribution function (CDF)** provides an alternative route: it's the probability up to a threshold. For discrete variables, it's a step function that jumps at each possible value by the probability at that value. For continuous ones, it's a smooth increasing curve. The CDF is especially handy for "less than or equal to" or "greater than" questions. If a problem asks "What's the probability the measurement is less than 20 mm?", you can directly give $F(20)$ (the CDF at 20). On the exam, if you have the PDF but need a cumulative probability, either integrate to get the CDF or recall known CDF forms for common distributions (e.g. the normal distribution's CDF is looked up in a table). Conversely, if you're given a CDF (sometimes an exam question might provide a CDF graph or formula and ask for probabilities), you can get probabilities from it: for discrete, differences in the CDF give you the PMF (e.g. $P(X = x_k) = F(x_k) - F(x_{k-1})$); for continuous, differentiate it to get the PDF.

Common exam traps:

- *Discrete vs Continuous confusion:* Identify the nature of the variable promptly. If it's countable (counts, integers, specific outcomes), use summation/PMF logic. If it's measurable (time, length, etc.), use integration/PDF logic. A classic mistake is summing a PDF at a point or integrating a PMF – catch yourself by checking units: summing probabilities yields a probability, integrating a density yields a probability.

- *Forgetting normalization:* If given a function and asked if it's a valid PDF/PMF or to find a missing constant, remember to enforce $\sum P = 1$ or $\int f = 1$. Many students lose points by forgetting to ensure the total probability is 1 (e.g. solving for a constant C in $f(x) = C \cdot g(x)$ such that $\int f(x) = 1$).

- *Misusing CDF vs PDF:* Don't plug values directly into a CDF thinking it's a probability density, and don't differentiate a PMF (which is just a list of probabilities) expecting something meaningful. Use the right tool: CDF for cumulative probabilities, PDF/PMF for point probabilities (discrete) or densities.

- *Boundary mistakes:* When computing $P(a < X < b)$, inclusive vs exclusive doesn't matter for continuous (because equality has probability 0), but it does for discrete (make sure to include or exclude the endpoint correctly). For instance, $P(X \leq 3)$ vs $P(X < 3)$ differ by $P(X = 3)$ in a discrete case. Read the inequality carefully and use the CDF appropriately.

K02.T01.S02 – Common Distribution Types (Binomial, Normal, Uniform, Exponential)

Principle Introduction – Subtopic Background: Many real-world engineering problems follow a few well-known probability distributions. The **FE Mechanical Exam** expects you to recognize and use these efficiently. The four staple distributions to know are:

- **Binomial Distribution:** A discrete probability distribution that describes the number of successes in a predetermined number of independent trials (each with an identical probability of success). Classic example: "What's the probability of getting exactly 3 defective items in a sample of 10, if each item has a 5% defect rate?" – That's binomial.
- **Normal Distribution (Gaussian):** A continuous, bell-shaped distribution characterized by a mean μ and standard deviation σ. It models many natural and measurement variations (e.g. dimensional tolerances, measurement errors, or any quantity that is the sum of many small independent effects). Example: errors in machined part dimensions often assume a normal distribution around a target value.
- **Uniform Distribution:** The simplest continuous distribution (there's also a discrete version) where all outcomes in a range $[a, b]$ are equally likely. It's used as a rough model when you have limited info – e.g. assuming an angle is "random between 0 and 360°" means a uniform distribution on that interval. Uniform is conceptually straightforward but shows up as the basis for simulations and some simplistic scenarios.
- **Exponential Distribution:** A continuous distribution often used for waiting times or lifetimes of components, characterized by a rate parameter λ. It's the go-to model for the time until an event occurs when events happen at a constant average rate (memoryless process). Example: time between random failures in a machine if the failure rate is constant, or the time until the next phone call in a call center if calls come in at a steady average rate.

Each of these distributions has specific **properties (parameters, mean, variance)** that you should know, and typical usage contexts. By familiarizing yourself with their "fingerprints" (e.g. binomial deals with counts & finite trials; normal is symmetric bell curve; exponential decays from a maximum at 0; uniform is flat), you can quickly classify exam problems and apply the correct formula. Below is a quick reference for each:

Exam Handbook Search Cues (Not affiliated with or endorsed by NCEES): Binomial distribution; normal distribution (Gaussian); uniform distribution; exponential distribution; standard normal table; combination $C(n, x)$ (for binomial coefficients)

Footnotes:

- *Units:* For **discrete distributions** like binomial, the outcomes x are counts (dimensionless) and probabilities p are dimensionless fractions. For **continuous distributions**, the variable x carries units (e.g. seconds, mm) and the PDF's units are the inverse of x's units (so that $f(x)\,dx$ is dimensionless probability). For instance, if X is time in hours for an exponential distribution, λ is in hours^{-1}. Keep units consistent if plugging into formulas (especially with rates like λ; if given a mean lifetime of 5 hours, then $\lambda = 1/5$ per hour).

- *Parameter conventions:* In exam problems, parameters might be given implicitly. For example, a normal distribution problem might just state "mean = 50, standard deviation = 5" without using μ, σ notation – you must assign those. Or a question might say "on average 3 failures per year" implying an exponential rate $\lambda = 3/\text{year}$. Be ready to extract parameters from wording.

- *The Standard Normal:* A special normal with $\mu = 0, \sigma = 1$. The exam handbook includes a **Z-table** of cumulative probabilities for the standard normal. You'll often need to convert a normal X to $Z = (X - \mu)/\sigma$ to use this table. *Search cue:* "unit normal distribution table". The table gives $F(z)$ for z or sometimes the area in the tail. Remember symmetric properties: $P(X > \mu + k\sigma) = P(X < \mu - k\sigma)$ due to symmetry.

- *Independence & identical trials (Binomial):* Binomial formula assumes each trial has the same probability p and that trials don't influence each other. If a problem violates these (e.g. sampling without replacement from a small population), it's not a binomial scenario (it might be hypergeometric instead, which is beyond our main scope here). But most FE questions stick to binomial where appropriate.

- *Memoryless property (Exponential):* This is a defining assumption for using exponential. If you see language like "constant failure rate" or "the process has no memory of how long it has gone without an event," exponential is the model. It also means $P(X > t) = e^{-\lambda t}$, a handy one-liner for "what's the probability the event hasn't occurred by time t" (reliability/survival probability).

- *Discrete Uniform:* For a discrete uniform on consecutive integers $a, a+1, \ldots, b$, the mean is still ($a + b$)/2. If there are $n = b - a + 1$ equally likely values, the variance is

$$\sigma^2 = \frac{n^2 - 1}{12} = \frac{(b - a + 1)^2 - 1}{12}.$$

You typically won't need this formula on the FE, but it's good to remember that the discrete and continuous uniform variances are not identical.

- *Combinatorics (Binomial):* The term $\binom{n}{x}$ is a combination count ("n choose x"). Calculators on the exam (like the TI-36X Pro or Casio fx-115) have an nCr function to compute this directly. Use it to avoid arithmetic mistakes with factorials. Always ensure you're using the correct values for n and x (order matters: $\binom{10}{3}$ is not the same as $\binom{3}{10}$, the latter is 0).

Variations & Related Forms: - Bernoulli & Binomial: A single trial with success probability p is a *Bernoulli* distribution (basically a yes/no outcome). The binomial is the sum of n independent Bernoulli trials. If $n = 1$, binomial reduces to Bernoulli (mean $= p$, var $= p(1 - p)$). Be aware of wording: if a question says "what is the probability of success in one trial," you might just apply p directly (Bernoulli), whereas multiple trials calls for binomial.

- **Binomial vs. Poisson:** The **Poisson distribution** (not listed above but worth noting) models the number of events in a continuous interval with a constant average rate. It can be derived as a limiting case of the binomial when n is large and p is small such that $np = \lambda$ stays moderate. For completeness: $P(X = k) = \frac{\lambda^k e^{-\lambda}}{k!}$. If you get a question like "a machine breaks down on average 2 times per year, what is the probability of 3 breakdowns next year?" – that's Poisson with $\lambda = 2$. The FE Mechanical spec emphasizes binomial & normal, but Poisson could appear conceptually or as a follow-up to exponential (since Poisson counts events and exponential gives the time between events in a Poisson process).

- **Normal Approximation:** A large binomial can be approximated by a normal distribution $N\left(\mu = np,\ \sigma = \sqrt{np(1-p)}\right)$ for computational ease. The exam might not require you to do this approximation explicitly (since you could compute directly with a calculator for moderately sized n), but it's good to know: e.g., $n = 100, p = 0.5$, the distribution of X is approx normal with mean 50, std ~5. For continuity correction: if approximating $P(X \le x)$, you might consider $P(X \le x + 0.5)$ in the normal domain, but again, use exact methods if possible. This note mostly helps intuition – that binomial histograms start to look bell-shaped when n is big.

- **Standardizing Normal:** Any normal random variable can be converted to standard normal for probability lookup: $Z = \frac{X - \mu}{\sigma}$. If a question gives a normal scenario and asks for a probability, your steps typically are: subtract the mean, divide by standard deviation, then use either the provided Z-table or calculator's error function if available. *Remember:* The exam's provided *normal table* usually gives $F(z) = P(Z \le z)$. For negative z, use symmetry: $F(-z) = 1 - F(z)$ (assuming the table is right-tail or vice versa). Practice reading the table beforehand so you're comfortable on test day.

- **Exponential & Reliability:** The exponential distribution represents a particular instance of the Gamma distribution, occurring when the shape parameter is equal to 1. It's frequently used in reliability engineering: if the mean time to failure is m, then $\lambda = 1/m$. Reliability $R(t) = P(\text{survive} > t) = e^{-\lambda t}$. The *half-life* $t_{1/2}$ (time by which 50% probability of event) is $\ln(2)/\lambda$. Sometimes an exam problem might implicitly test the memoryless property: e.g., "Given that a component has lasted 100 hours, what's the probability it lasts another 100 hours?" – for exponential, the answer is the same as originally lasting 100 hours from new.

- **Uniform & Triangular:** The uniform is often used as a simplifying assumption. Another distribution, *triangular*, is sometimes used for rough estimates (with a min, max, and mode forming a triangle shape). Triangular wasn't explicitly listed in scope, but if you ever see it, know it's just a piecewise linear distribution used for approximation. It won't require heavy calculation beyond geometry of area. Uniform, however, is straightforward: area of a rectangle = base * height, so probability = interval length * (1/(b-a)).

Special Notes – Calculator Use:

- **Binomial & Poisson:** Utilize the nCr (combination) function for binomial coefficients. For large n or x, doing $\frac{n!}{x!(n-x)!}$ by hand is impractical, but calculators can handle it. Also consider built-in probability functions if your calculator has them (some advanced scientific calculators have a binomial PDF function where you input n, p, x directly, but it's fine to use the formula manually).

- **Normal Distribution:** The FE exam expects you to use the provided normal table for cumulative probabilities. Your calculator likely does **not** have a built-in normal CDF function (and even if it did, relying on it without the table might not be advisable due to exam standards). Practice reading the exam handbook's standard

normal table: find the row for the first two digits of z and column for the second decimal. For inverse problems (finding z for a given probability), you scan the table values. Mark on your handbook or notes typical Z values: e.g., $Z = 1.645$ for 0.95 area, $Z = 1.282$ for 0.90, etc. This saves time.

- Exponential Calculation: Calculating $e^{-\lambda t}$is straightforward on any scientific calculator. Just be careful with parentheses when entering the exponent. For example, if $\lambda = 0.25$and $t = 5$, you compute $e^{-\lambda t} = e^{-0.25 \cdot 5} = \exp(-0.25 \cdot 5)$. On most calculators you would type e^(-0.25*5) (or use an exp key, if available), making sure the entire product $-0.25 * 5$is in the exponent. Since this is a purely numerical calculation, degree/radian mode does not matter; it only affects trigonometric functions.

- Uniform Simplicity: With uniform, calculations simplify greatly. Often, a uniform question might be conceptual (like "the probability is proportional to the interval length within [a,b]"). Just remember the density $1/(b-a)$ and use basic geometry for probabilities (area of rectangle). Uniform is unlikely to need heavy calc work—more about recognizing when things are "equally likely in a range."

Explanation & Analysis (by distribution):

- **Binomial Distribution:** Use this when you have a fixed number n of independent trials and want the probability of exactly x successes. Each trial is a yes/no (success/failure) with probability p of success. For example, suppose on the exam you see: *"A quality control test involves inspecting 5 widgets. Each widget has a 0.1 probability of being defective, independent of others. What is the probability exactly 2 are defective?"* This screams *binomial* with $n = 5,\ p = 0.1,\ x = 2$. You'd compute $P(X = 2) = \binom{5}{2}(0.1)^2(0.9)^3$. Here $\binom{5}{2} = 10$, so $P = 10 \times 0.01 \times 0.9^3 \approx 0.0729$ (be prepared to do such calculations). On the flip side, you may need $P(\text{at most } 2)$, then you sum $P(X = 0) + P(X = 1) + P(X = 2)$. The binomial mean np gives you the expected count of successes (in our example $5 * 0.1 = 0.5$ defects on average) – sometimes an exam question might indirectly check if you understand that (like asking for expected value, though that's usually in the statistics section).

- **Term-by-term in formula:** n is total trials (unitless count), x is the count of successes (also unitless), p is probability of success (dimensionless). The combination $\binom{n}{x}$ is a pure number of ways to choose which trials succeed. $(0.1)^2(0.9)^3$ in our example is the probability of any one specific pattern of 2 successes and 3 failures; multiplying by 10 accounts for the different patterns.

- **Common pitfalls:** using the wrong n or p (e.g. misreading the problem's success probability, or confusing "exactly" vs "at most"). Also watch out for the wording "success" – sometimes the quantity of interest might be "failures" (then p would be failure probability if you define X as failures). Define your success event clearly to apply p correctly. If in doubt, break the event into independent trials in your mind: that clarity will guide n and p.
  Exam tip: If n is large and x is large too, the direct calculation might be tedious; but FE problems are usually set up so things cancel or the arithmetic is reasonable. For instance, they might give $p = 0.5$ or a scenario where nCk is nice. If not, your calculator's combination function will save you. Remember to interpret any factorial-like notation correctly (sometimes they might use notation like ${}^nC_x$ for combinations).

- **Normal Distribution:** This is arguably the most important continuous distribution for the exam. Many phenomena are assumed normal, and it also underpins other topics like confidence intervals and control charts. The formula $f(x) = \frac{1}{\sigma\sqrt{2\pi}} e^{-\frac{(x-\mu)^2}{2\sigma^2}}$ is good to know conceptually (bell shape centered at μ), but in practice you won't plug numbers into that formula to get probabilities on the exam – you'll use the cumulative properties.

  For example, an exam question might state: *"Diameters of a bolt are normally distributed with mean 10.0 mm and standard deviation 0.1 mm. What percentage of bolts have diameter between 9.9 mm and 10.1 mm?"*

  To solve, you convert 9.9 and 10.1 into Z-scores: $Z_{low} = (9.9 - 10.0)/0.1 = -1.0$, $Z_{high} = (10.1 - 10.0)/0.1 = +1.0$. Then you'd look up $P(Z \le 1.0)$ and $P(Z \le -1.0)$. Typically, $P(Z \le 1.0) \approx 0.8413$ and $P(Z \le -1.0) = 0.1587$ (because of symmetry). The probability in between is $0.8413 - 0.1587 = 0.6826$, about 68.3%. This aligns with the well-known **68-95-99.7 rule** (within ±1σ is ~68%). On the exam, you might recall this rule for quick estimates or to check your table lookups.

- **Term-by-term in formula:** μ has the same unit as X (e.g. mm), it's the center. σ also has that unit (mm) and measures spread. $(x-\mu)^2/(2\sigma^2)$ in the exponent is unitless, as it should be for the exponent of e. If $x = \mu$, the exponent is 0 so $f(\mu) = 1/(\sigma\sqrt{2\pi})$, the maximum height of the curve. If x deviates from μ, the exponential part makes the value drop. The normal distribution extends to $\pm\infty$, but probabilities far in the tails are tiny.

- **Common pitfalls:** confusing standard deviation and variance (remember variance = σ^2). Another is misinterpreting table values: ensure you know if the table gives you left-tail $P(Z \le z)$ or some other convention. Also, when a question asks a percentile (e.g. "what diameter is exceeded by 95% of bolts?"), you have to invert the process: find z such that $P(Z \le z) = 0.95$ (that $z \approx 1.645$), then unstandardize: $x = \mu + z\sigma$. Always draw a quick bell curve and shade the area in question; label the mean and relevant σ positions – this visualization prevents errors in subtracting wrong areas or using the complement incorrectly.

  Exam tip: Some calculators (like the TI-36X Pro) can compute the error function or normal CDF for you, but using them isn't as straightforward as using the provided table and can waste time. Stick to the standard approach unless you've practiced the calculator's statistical functions thoroughly. Save precious exam minutes by knowing how to quickly approximate or bound answers: e.g., if asked if something is unusual (say $Z > 3$), you know $P(Z > 3)$ is about 0.13% (very low). They might test conceptual understanding by asking something like "if the tolerance is set at μ ± 3σ, what fraction is expected

to fall outside?" – you should answer ~0.3% (because ~99.7% are within). So indeed, memorize 1σ ~68%, 2σ ~95%, 3σ ~99.7% as a quick mental reference.

- **Uniform Distribution:** This one is straightforward: everything in $[a, b]$ is equally likely. Suppose an exam question says: *"An angle θ is assumed uniformly distributed between 0 and 2π radians. What is the probability that θ lies between π/2 and π?"* Because it's uniform, that probability is just the fraction of the interval length: $\frac{\pi-\pi/2}{2\pi-0} = \frac{\pi/2}{2\pi} = 1/4 = 25\%$. You can also do it by the PDF: $f(\theta) = 1/(2\pi - 0) = 1/(2\pi)$. Then $P(\pi/2 \le \theta \le \pi) = \int_{\pi/2}^{\pi} \frac{1}{2\pi} d\theta = \frac{1}{2\pi}(\pi - \pi/2) = 1/4$.

  Term-by-term: a, b have units of X. The PDF $1/(b-a)$ has units $1/X$. The uniform CDF is $F(x) = \frac{x-a}{b-a}$ (linear from 0 to 1 as x goes from a to b).

- **Common pitfalls:** forgetting that the support is finite – if a question asks outside the range, the probability is 0 beyond the endpoints. Another pitfall is mis-applying uniform when it's not appropriate: uniform is *only* when every outcome in an interval is equally likely. If there's any reason some values are more favored, it's not uniform. However, often exam problems explicitly say "assume a uniform distribution" if they want you to use it. They might also give you a piecewise PDF (like $f(x) = C$ on [a,b], 0 outside) and ask you to find C; recognize that as uniform where $C = 1/(b-a)$. The calculation of mean $(a+b)/2$ is intuitive – midpoint – and variance $(b-a)^2/12$ you can derive or memorize (not a bad idea to remember that number 12 in denominator; it often shows up if you need to compute second moment or something quickly). *Exam tip:* If the exam throws a weird continuous distribution at you (say a triangular distribution as mentioned, or something like "the PDF is proportional to x on [0,2]"), approach by remembering the uniform as a baseline. First, find the normalization constant by ensuring total area = 1. Then answer whatever probability or mean question using integration. Those are just one step beyond uniform, but uniform itself is the easiest case.

- **Exponential Distribution:** This distribution commonly appears in reliability and Poisson process contexts. A typical exam question might be:

  "The time (in hours) between machine failures is exponential with mean 50 hours. What is the probability that the machine runs for at least 100 hours without failure?"

  Here, mean $= 50$ implies $\lambda = 1/50$ per hour. "At least 100 hours without failure" translates to $P(X > 100)$. For exponential, $P(X > t) = e^{-\lambda t}$. Plugging in $\lambda = 0.02, t = 100$, we get $P(X > 100) = e^{-0.02 \cdot 100} = e^{-2} \approx 0.1353$ (13.5%). You didn't even need the PDF for that; you could also integrate the PDF: $P(X > 100) = \int_{100}^{\infty} 0.02\, e^{-0.02x} dx$ which also yields e^{-2}.

- **Term-by-term:** λ has units $1/\text{hours}$ in this case, x is hours, λx is dimensionless in the exponent. The initial value $f(0) = \lambda$ means the highest instantaneous probability density is at 0, and it decays as x increases. The CDF is $F(x) = 1 - e^{-\lambda x}$ (which gives the probability the event has happened by time x). The memoryless property means the distribution of "remaining life" given you've lasted some time is the same as the original distribution.

- **Common pitfalls:** confusing the exponential with a bell-curve distribution – it's not symmetric at all; it's heavily skewed right (a lot of mass near 0 with a long tail). Another mistake is using the mean directly as if it were a cutoff (like thinking $P(X > 50)$ must be 0.5 – that's not true; for exponential $P(X > 50) = e^{-1} \approx 0.37$, so there's a 37% chance to exceed the mean). Also, sometimes people mix up the roles of λ and mean: if given λ explicitly, use it directly; if given mean m, remember $\lambda = 1/m$. Check units: if mean is 50 hours, $\lambda = 0.02\text{hour}^{-1}$. If mean is 50 minutes, convert to hour if needed to match rate units.

  Exam tip: Recognize exponential situations by keywords: "constant rate", "memoryless", "time between events". If a question involves an exponential, there's often a quick solution: either using $P(X > t) = e^{-\lambda t}$ for at-least type questions or $P(X \le t) = 1 - e^{-\lambda t}$ for within-time questions, or computing a percentile time via $t_p = -\frac{1}{\lambda}\ln(1-p)$ (inverting the CDF for something like "find the time by which there's a 90% chance of failure"). These formula manipulations are algebraically simple – just be comfortable with natural logs and exponentials.

Common exam traps (across these distributions): - *Using wrong distribution:* The exam may present a scenario where more than one distribution could superficially seem to apply. For example, the number of events in a time period could be binomial if the number of trials is fixed or Poisson if not bounded; time until event could be exponential, but if there's a memory or aging factor, exponential might not hold. Pay attention to clues: "fixed number of trials" → binomial; "constant average rate, independent events" → Poisson counts and exponential wait times. If you misidentify, you'll apply the wrong formula. - *Parameter mix-ups:* Ensure you plug in the correct values for parameters. In a rush, it's easy to put $q = 1 - p$ in the wrong place for binomial or use variance where stdev is needed for normal. For normal distributions, always clarify: are you dealing with X values or Z values? And convert appropriately.

- *Calculator rounding:* Probability answers are often required either as a fraction, a percentage, or a decimal to a certain precision. The FE exam is computer-based and likely multiple-choice, so they might provide a tolerance for numeric answers. Keep at least 3-4 significant figures in intermediate steps to avoid rounding error, especially for normal distribution cumulative calculations. For instance, don't round Z too early or you might pick a wrong table entry. - *Interpreting "less than" vs "greater than" phrasing:* A question might ask, "What is the probability the diameter is **above** 10.1 mm?" which means $1 - F(10.1)$ for normal. It's easy under time pressure to accidentally compute $F(10.1)$ instead. Always translate words to math carefully: above = greater than, below = less than, at most = ≤, at least = ≥, between = difference of two CDFs. Writing that down in symbols before computing can save you from a trap.

K02.T01.S03 – Empirical Distributions (Terminology and Concept)

Principle Introduction – Subtopic Background: An *empirical distribution* is the distribution observed in real data, as opposed to a

theoretical distribution model. In other words, when you collect sample data and look at how frequently values occur, you're constructing an empirical distribution. Key points include:

- **Definition:** The empirical distribution of a dataset assigns probability based on observed relative frequencies. For a sample of size N, each data point contributes $1/N$ probability. If you plot a histogram or stepwise cumulative curve from data, that's the empirical distribution function (EDF) or empirical cumulative distribution function (ECDF).
- **Usage:** Empirical distributions are used when you don't assume a specific theoretical distribution, or you want to validate if data *fits* a certain distribution. On the FE exam, you might see an empirical distribution in the form of a histogram or just be asked conceptually what it means. It's more about terminology – understanding that "empirical" means "from data/experience" (observed) rather than derived from a known formula.
- **Comparison to theoretical:** Empirical distributions approximate the true underlying distribution and improve as sample size grows (by the Law of Large Numbers). If you have a large enough sample, the empirical histogram should resemble the probability density function of the process that generated the data. But with limited data, the empirical distribution can be jagged or irregular.
- **Terminology:** Some sources informally talk about the 'distribution of the sample' or 'sample distribution' when they mean this empirical distribution. Just don't confuse that with a **sampling distribution**, which is the distribution of a statistic (like the sample mean) across repeated samples. Key related terms: *relative frequency distribution* (essentially the same concept, focusing on frequencies of data intervals), and *empirical CDF* (a non-decreasing step function that jumps by $1/N$ at each data point in sorted order).

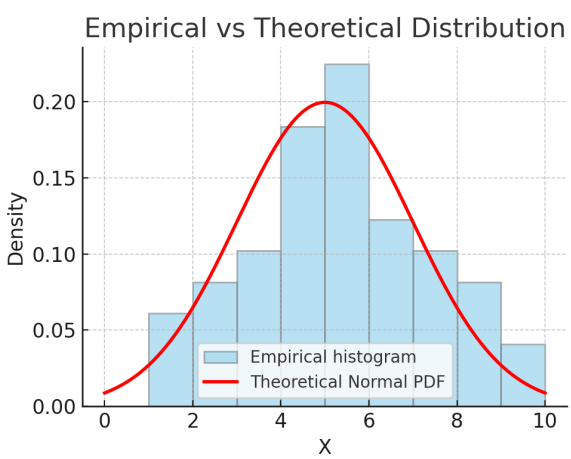

Example: The bars show an empirical histogram of 50 sample values, and the curve is the theoretical normal distribution that might underlie the data. The histogram's shape is an empirical distribution – it approximates the true probability density but with some random irregularities due to limited data. As the sample size increases, the empirical histogram would become smoother and closer to the red curve. On the FE exam, you might not have to draw such plots, but you should understand that the empirical distribution is essentially "what the data shows," while a theoretical distribution (like the red normal curve) is an idealized model.

Exam Handbook Search Cues (Not affiliated with or endorsed by NCEES): empirical distribution; sample distribution; histogram; observed frequency

Footnotes: - *Not the "Empirical Rule":* Don't confuse **empirical distribution** with the **empirical rule (68–95–99.7)** for normal distributions. The empirical *rule* is a specific guideline about normal distribution percentages, whereas an empirical *distribution* is a general concept about data-derived distributions. The wording on the exam could include "empirical" in either context, so use clues: if it's about one standard deviation, it's the rule; if it's about data/histogram, it's the distribution.

- *ECDF:* The empirical cumulative distribution function is often denoted $\hat{F}(x)$. It's calculated as $\hat{F}(x) = \frac{\text{number of data points} \leq x}{N}$. It jumps by increments of $1/N$. While you likely won't need to compute one on the FE, conceptually it's good to know this is how you formally define the distribution from a sample.

- *Applications:* Empirical distributions are used in statistical inference (e.g. the foundation of the Kolmogorov-Smirnov test for goodness of fit) and bootstrapping methods, but for FE purposes, you mostly need a broad understanding. If given data and asked probabilities, essentially you'd use the data frequencies as your distribution – that *is* empirical distribution in action.

- *Visualization:* A histogram, as shown in the example, or a bar chart for discrete outcomes, is the primary way to visualize an empirical distribution. Each bar's height = relative frequency = probability estimate for that bin. As exam reference, if a question provides a histogram and asks for probability in a range, you'd add up the bar frequencies in that range.

- *Limitations:* An empirical distribution is only as good as the sample. With small samples, it might mis-represent the true underlying distribution (show spurious peaks or gaps). The exam could indirectly test this by asking something like, "Which of the following is true about empirical distributions as sample size increases?" – the correct idea: it converges to the true distribution (thanks to more data).

Explanation & Analysis:

An **empirical distribution** is basically letting the data speak for itself. Imagine you perform an experiment and record the outcomes 100 times. Now you want to know the probability of a certain outcome. Without assuming any fancy model, you could say "it happened 23 out of 100 times, so approximately 0.23 probability." That *is* using the empirical distribution (23% of the data fell into that outcome). If the outcome is a continuous measurement, you might group data into bins (intervals) to form a histogram. Each bin's relative height = fraction of data in that bin is your empirical estimate of the probability for a value in that range.

On the FE Mechanical Exam, you might not be asked to calculate an empirical distribution from scratch, but you could be given one in a question. For instance, they might present a small table:

- Outcome A occurred 5 times
- Outcome B occurred 3 times
- Outcome C occurred 2 times (out of 10 trials total)

They could then ask something like, "What is the empirical probability of Outcome A?" You'd answer 0.5 (5/10). Or they might ask "Based on the empirical distribution above, what is the probability of either A or B?" – you'd add 0.5 + 0.3 = 0.8. These

are straightforward once you recognize that empirical probability = observed frequency / total observations.

Another angle: sometimes a question gives a histogram of some experimental measurements and asks you to estimate probabilities or quantiles. For example, a histogram might show frequencies of some measurement in bins, and you might be asked "approximately what fraction of observations were below X?" – you'd sum the frequencies up to the bin containing X and divide by total. That is effectively reading the empirical CDF from the histogram.

Term-by-term, there isn't a formula like the others, but conceptually: each data point x_i can be thought of as contributing a probability mass $1/N$ at x_i. Thus, the empirical *mass* function (for discrete or treated-as-discrete data) is $\hat{P}(X = x_i) = 1/N$ for each observed data point (and 0 for other points not observed). If data has repeats, then those points get multiple $1/N$ counts (so it's k/N if a value appears k times). For continuous measurements binned, the empirical density in a bin is roughly (count in bin)/($N \times$ bin width). But you don't need to remember that formula – just know how to interpret the picture or table.

Where it matters on the exam: Empirical distribution concepts might appear in questions about sampling or "experimental results". If a question says "according to empirical data…" it means they got it from observation, not theory. They may test if you understand the difference: e.g., "The engineer assumed a normal distribution for wear life, but the empirical distribution was skewed. What does this imply?" (It implies the normal assumption might be wrong; the data suggests a different distribution.) Or a question could involve comparing an empirical distribution to an expected theoretical one, asking which statistical test or measure might be used – though detailed statistical tests are probably beyond FE scope, a qualitative understanding is good.

Common pitfalls:

- *Over-interpreting small samples:* Students might see a small dataset and try to fit a distribution when the question simply expects using the frequencies given. For example, if only 5 observations are given, don't attempt to assume a normal or something unless prompted; likely they want an empirical probability estimate.

- *Misreading histograms:* Ensure you know the difference between frequency (count) and probability (relative frequency). If a histogram bar's height is 5 and total observations are 50, the probability for that bin is 0.1 (10%). If the histogram is normalized to show probability density, then the area of bars corresponds to probability. The exam usually clarifies by either labeling frequencies or probabilities on the axis.

- *Ignoring empirical evidence:* In some conceptual questions, an empirical distribution might contradict an assumption. For instance, you might be given data that is clearly not symmetric, yet someone assumed normal. The "trap" answer would be to do a normal-based calculation anyway, but the better answer might be acknowledging the empirical distribution's shape (maybe it's more like exponential). So, pay attention if the question hints at using the data itself versus a theoretical distribution.

Micro-check: True or False?

"As the sample size increases, an empirical distribution will more closely resemble the true probability distribution of the random variable." – **True.** (This statement reflects the Law of Large Numbers – with more data, your observed frequencies stabilize around the actual probabilities.)

Topic 02 - Measures of Central Tendency and Dispersion

Topic Intro: In engineering, numbers tell a story—**measures of central tendency** (like the mean, median, and mode) summarize the typical value in a dataset, while **measures of dispersion** (range, variance, standard deviation) describe how spread out the data is. This balance between "center" and "spread" matters on the FE Mechanical Exam because many problems give you data (e.g. material strengths, test measurements, or survey results) and ask for a representative value or how much variability to expect. A solid grasp of these concepts lets you quickly choose the right statistic—say, computing an average or estimating uncertainty—so you can interpret data confidently. Typical question scenarios include finding the average and standard deviation of a set of measurements, comparing **mean vs. median** for skewed data, or determining a **confidence interval** (with a margin of error) for an estimated quantity. In this chapter, we'll master each of these tools step by step, always tying them back to what you'll do on exam day. *(Not affiliated with or endorsed by NCEES.)*

K02.T02.S01 – Measures of Central Tendency (Mean, Median, Mode)

Principle Introduction – *Measures of central tendency* are statistics that pin down the "middle" or typical value of a dataset. They answer questions like *"Given all these numbers, what's a good representative value?"* Common measures include:

- **Arithmetic Mean (Average):** Sum of all values divided by the count. Uses every data point, so it's sensitive to *outliers* (very high or low values).
- **Median:** The middle value when data are sorted in order. Splits the dataset in half. It ignores whether extreme values are far out—so it's *resistant to outliers*.
- **Mode:** The value that appears most often in a dataset. It is especially helpful for categorical variables or for determining the most common observation. A dataset can have **no mode** (if all values are unique) or be *bimodal*/*multimodal* (if multiple values tie for highest frequency).

Each measure has its niche. For example, the mean is great for balanced data (it's the "center of mass" of the data), but if one measurement is way off, the median might give a better sense of a typical value. On the FE exam, **choose the measure** that the question calls for: if it says "average," that usually implies the mean (unless context suggests otherwise), whereas "middle value" or mentions of outliers hint at the median.

Exam Handbook Search Cues (Not affiliated with or endorsed by NCEES): *mean, arithmetic mean, median, mode, average, central tendency* – These are keywords you'd use in the exam's reference handbook to find relevant formulas or definitions quickly.

Footnotes: - In notation, the **population mean** is often denoted by μ (mu), while the **sample mean** is denoted by $\bar{X}$ (X-bar). Both are calculated the same way; the difference is whether you're considering the entire population or just a sample. Units of μ and $\bar{X}$ are the same as the individual data values. - The median is sometimes denoted $\tilde{X}$ or just described in words. There's no special symbol on the exam reference for median. - The mode typically has no standard symbol; it's usually identified contextually (e.g. "the mode is 5"). If data are continuous (no exact repeats), we often say no mode or treat mode in terms of a histogram peak. - All these measures have **units identical to the data**. If your data is in mm, the mean, median, and mode will also be in mm.

Variations and Related Forms: Besides the simple average, you may encounter:

- **Weighted Mean:** When some data points count more than others, use $\bar{X}_w = \frac{\sum w_i X_i}{\sum w_i}$. This appears if, say, combining class averages with different class sizes. It's essentially a mean where each value X_i has a weight w_i.

- **Geometric Mean:** $(\prod_{i=1}^{n} X_i)^{1/n}$. Used for quantities like growth rates or ratios (for example, average growth factor). It's less common in FE Mechanical problems, but it's good to know it exists as a measure of central tendency for multiplicative processes.

- **Midrange:** Sometimes defined as $(X_{\max} + X_{\min})/2$. It's a simple midpoint of extremes (not used often, but conceptually the "center" of range).

- In a perfectly **symmetric distribution** (like a normal distribution without skew), the mean, median, and mode coincide at the center. In **skewed distributions**, they separate: e.g. for right-skewed data (a few high outliers), mean > median > mode. Exam questions may indirectly test this by asking which measure is largest or smallest for a skewed dataset.

Special Notes – Calculator Tips:

Computing a mean or median by hand is straightforward for small sets (which is typical on the FE exam). If you have a longer list of numbers, **exam-approved calculators** (like the TI-36X Pro or Casio fx-991 series) have a built-in statistics mode. You can enter data points and get the mean (usually labeled $\bar{x}$) with one command. *However, always double-check manual vs calculator results, especially for median or mode – some calculators might not directly give median or mode, so you might still have to pick those out by sorting mentally.*

Equation Passport – Arithmetic Mean (Average)

Formal definition: The arithmetic mean is the sum of all data values divided by the number of values. It gives the central value as if each observation contributed equally to the total. This is the default "average" in most contexts.

$$\bar{X} = \frac{1}{n}\sum_{i=1}^{n} X_i$$

Variables and units:

- $\bar{X}$ = sample mean (also called **arithmetic mean**; same units as each X_i). If referring to an entire population, we use μ for the population mean, but calculation is the same.
- X_i = the ith data point or observation (in given units, e.g. seconds, psi, etc.).

- n = number of observations (dimensionless count). For a population, often denoted N (total number in population), but conceptually similar formula $\mu = \frac{1}{N}\sum_{i=1}^{N} X_i$.

Assumptions and scope:

- Data are numerical (interval or ratio scale) so that adding them makes sense.
- No specific distribution assumptions; the mean always exists as long as n is finite (even if data are skewed or have outliers—the mean can be computed, though it might not be representative in those cases).
- Every data point is treated equally in influence. (If that's not desired, use a weighted mean or median, etc.)

Limit tests (sanity checks):

- If all n values are the same, say $X_1 = X_2 = \cdots = X_n = C$, then $\bar{X} = C$. (The average of identical values is that value.)
- If one value is extremely large compared to others, $\bar{X}$ will be pulled in that direction (higher or lower). For example, data $\{2,3,4,100\}$ has $\bar{X} = 27.25$, which is not representative of the majority of the data—indicating sensitivity to an outlier.
- As $n \to 1$, the mean $\bar{X}$ just equals that single data point (no averaging needed when there's only one value).
- **Use vs. siblings:** Use the arithmetic mean whenever you need the "center of gravity" of data. It's appropriate in most cases, especially if asked for an "average" outright. **Use median instead of mean when** a few outliers would skew the result (median gives a better typical value in those cases). **Use mode when** the question is about the most common value (especially for discrete or categorical data). If growth rates or ratios are involved over multiple periods, consider the geometric mean rather than the arithmetic mean.

Common exam traps:

- **Forgetting to divide by n:** It's easy under time pressure to sum the values and forget the final division. Always check that your average is within the range of the data (it should be between min and max; if not, you likely missed dividing).
- **Misidentifying n:** If data are presented in a frequency table or if a value repeats, be sure to count all entries. Sometimes exam questions might compress data (e.g. "value 5 occurs 3 times"), so n would be the total count (here 3 for that value).
- **Population vs. sample notation:** Don't confuse formulas for mean with those for variance. The mean formula uses n in the denominator for both sample and population. (It's variance that differs by $n - 1$ vs N – more on that later.)
- **Units consistency:** If the dataset involves units (like lengths, times, etc.), all values must be in the same unit before averaging. Converting units mid-calculation is a recipe for mistakes (e.g., don't average 3 m and 150 cm as "3 + 150 / 2" without unit conversion!).

Definition Passport – Median

Plain-language definition: The **median** is the middle value of an ordered dataset. Half the observations lie below it and half lie above it. If there's an even number of data points, the median is defined as the average of the two middle values.

- **Where it matters (exam impact):** Median shows up in questions involving **skewed data or outliers**. For instance, if one extreme value is present, a question may ask for the median knowing it won't be affected by that extreme as much as the mean would be. You might see a small set of values and be asked for the median, especially if they want to emphasize robustness against outliers or the "50th percentile."
- **Pitfall or confusion point:** A common mistake is forgetting to sort the data before picking the middle. The median isn't just the "middle in the given order," it's the middle in *magnitude order*. Also, when n is even, remember to **take the average of the two central values** – the median might not actually be one of the original data points in that case. (E.g., data = {8, 1, 4, 2} sorted gives {1, 2, 4, 8}, the two middle values are 2 and 4, so median = 3, which wasn't in the list.)
- **Micro-check:** *True/False:* The median of $\{5,7,2,10\}$ is 6. **Answer:** True – ordering the set as {2, 5, 7, 10}, the middle two values are 5 and 7, so the median is $(5 + 7)/2 = 6$.

Definition Passport – Mode

Plain-language definition: The **mode** is the most frequently occurring value in a dataset. It is the "most popular" data point. A dataset can have one mode (unimodal), more than one mode (if multiple values tie for highest frequency), or even no mode (if all values occur only once).

- **Where it matters (exam impact):** Mode is less commonly asked on the FE exam than mean or median, but it can appear in questions about frequency distributions or histograms. It's particularly relevant for categorical data (e.g., which failure type happened most often) or discrete data. If an exam question provides a histogram or a list of repeated values, asking for the mode is straightforward: just pick the highest bar or the value that appears most.
- **Pitfall or confusion point:** Don't confuse *frequency* with *magnitude*. The mode cares only about count, not size. A value of "2" could be the mode if it appears 10 times, even if other values are larger but appear fewer times. Also, if two values appear equally often and more than others, the data set is bimodal – **the exam might accept either or both as correct, depending on how the question is phrased**. When there's a tie, list all modes. If every value appears once, correctly state there is *no mode* (or "no single mode").
- **Micro-check:** *Quick question:* The set {3, 1, 4, 3, 5, 1, 3} is given. What is the mode? **Answer:** 3 (because 3 appears three times, more than any other number).

Explanation & Analysis: At their core, mean, median, and mode are all trying to answer "What's typical for these data?" but they do so in different ways:

- The **mean** $\bar{X}$ literally *balances* the data – imagine each data point as a weight on a lever, the mean is the balance point. It uses every value in its calculation. This makes it very informative but also vulnerable to any one value's influence. For example, if you're averaging five test results and one is *zero* (perhaps a missed test), the mean drops significantly; that may or may not reflect a "typical" performance, depending on context. On exam day, use the mean when asked for an "average" or when all values should be accounted for evenly.

- The **median** is like the middle child – it cares about order, not the actual distances between values. Sorting the data is the key step: for an ordered list $X_{(1)} \leq X_{(2)} \leq \cdots \leq X_{(n)}$, if n is odd, median = $X_{\left(\frac{n+1}{2}\right)}$; if n is even, median = $\frac{X_{(n/2)}+X_{(n/2+1)}}{2}$. The median gives a sense of the central position without getting dragged by extremes. For instance, consider incomes in a company: a few high earners can inflate the mean, but the median income might better represent a "typical" employee. The FE exam might implicitly test this concept by, say, presenting a skewed set and asking which measure (mean or median) is higher.

- The **mode** identifies the most common result. It's the easiest to find in a frequency table or histogram (just find the tallest bar or largest count). Its drawback is that it might not exist or might not be unique. For example, the data set {100, 4, 3, 2} has no repeated values – no mode. In quality control or material defect categories, the mode could tell you the most frequent defect type. In pure numeric problems, mode is less often needed unless the question specifically asks for it. Still, be ready: if they give you a list like {2, 5, 5, 5, 7, 9}, recognizing that 5 is the mode is straightforward.

One more thing: **sample vs population** in this context doesn't change how you compute mean/median/mode on the exam – you'll list or sum the given values either way. The distinction is mostly in notation (sample mean $\bar{X}$ estimates population mean μ). But it's good to be aware: if a problem says "the average length in a sample of 5 bolts is 12.2 mm," 12.2 mm is $\bar{X}$ (a statistic). If it says "the true average length of all bolts is 12.2 mm," that 12.2 mm would be μ (a parameter).

Exam tip: such wording nuances rarely affect calculation, but they might appear in theoretical questions.

Finally, always sanity-check your results. If you compute a mean that lies outside the minimum or maximum value in the set, something's wrong (you might have forgotten a term or divided incorrectly). For median and mode, ensure the answer is one of the data values (or an average of two data values for median even n; or clearly state "no mode" if appropriate). It's easy to make simple arithmetic mistakes under pressure, so double-check by a quick recompute or using your calculator's statistics function if time permits.

K02.T02.S02 – Measures of Dispersion (Range, Variance, Standard Deviation)

Principle Introduction – *Measures of dispersion* quantify **variability**: they tell you how spread out the data values are around the center. Two datasets might have the same mean but completely different spreads – and that can be crucial. For example, if two machine parts have the same average diameter, but one machine produces parts with very consistent diameters and another produces a wide scatter, the difference shows up in dispersion metrics like variance or range. On the FE Mechanical exam, you may be given a set of values and asked to compute the **standard deviation** or **variance**, or to compare which dataset is "more variable."

Dispersion matters because engineers need to understand reliability and precision: a low dispersion means measurements cluster tightly (good for quality control), while a high dispersion indicates inconsistency. The basic tools here are:

- **Range (R):** The simplest measure – the spread from the minimum to the maximum value; numerically, $R = x_{\max} - x_{\min}$. It's quick to get but only uses two data points, so it can be misleading if those two are outliers.
- **Variance (σ^2 or s^2):** The average of the squared deviations from the mean. Think of it as a measure of the "spread" in squared units. A larger variance means data are more spread out.
- **Standard Deviation (σ or s):** The square root of variance. This brings dispersion back to the original units, making it easier to interpret. It essentially tells you on average how far data points deviate from the mean.

We distinguish **population** vs **sample** for variance and standard deviation because the formulas differ subtly (using N vs $n-1$ in the denominator). On the exam, unless explicitly told you have the whole population, you'll often use the sample formula (especially if given a small data sample). The reference handbook provides both forms; being aware of which to use is key. Remember: *sample variance uses $n-1$ in the denominator* (this corrects bias in estimating the true population variance from a sample).

Exam Handbook Search Cues (Not affiliated with or endorsed by NCEES): *range, variance, standard deviation, standard dev, variability, dispersion* – Use these terms to quickly locate formulas for s^2, σ^2, s, σ and related definitions in the reference. (The handbook often groups "Dispersion, Mean, Median, and Mode" together, so you might find range and variance near where mean was.)

Footnotes:

- **Range (R):** $R = X_{\max} - X_{\min}$. It has the same **units as the data**. It's extremely sensitive to outliers: one crazy high or low value can make the range huge even if the rest are clustered.

- **Population vs Sample Notation:** Population variance is σ^2 (sigma squared), and population standard deviation is σ. Sample variance is s^2, and sample standard deviation is s. The FE exam reference uses these symbols distinctly. Typically, $\sigma^2 = \frac{1}{N}\sum_{i=1}^{N}(X_i - \mu)^2$ and $s^2 = \frac{1}{n-1}\sum_{i=1}^{n}(X_i - \bar{X})^2$. Notice the $n-1$ for sample variance.

- **Units:** Variance is in **squared units** of the original data (e.g., if measurements are in mm, variance is in mm²). Standard deviation brings it back to the original units (mm). This is why standard deviation is generally more interpretable (e.g., "on average, lengths vary by about 0.5 mm" makes more sense than "variance is 0.25 mm²").

- **Independence note:** Sometimes you'll see formulas for the variance of a sum or difference (e.g., $\sigma_{X+Y}^2 = \sigma_X^2 + \sigma_Y^2$ if X and Y are independent). That's an advanced point: if needed, the exam would hint that two sources of variance add when independent (like tolerances stacking up). But our focus here is on computing dispersion for one dataset.

Variations and Related Measures:

- **Standard Deviation vs. Variance:** These convey the same information in different units. The exam might ask for either.

Standard deviation is simply $\sqrt{\text{variance}}$. If you compute variance first, don't forget to take the square root for standard deviation (unless the question specifically wants variance).

- **Coefficient of Variation (CV):** Defined as CV $= \frac{s}{\bar{X}}$ (for a sample) or σ/μ (for a population). It's a dimensionless measure of relative variability – useful to compare variability between datasets with different units or widely different means. For example, a CV of 0.1 (or 10%) means standard deviation is 10% of the mean. While CV isn't always explicitly asked on the FE, it's good to know conceptually in case a question asks which dataset is "more variable relative to its mean."

- **Alternate spreads:** You might hear of *mean absolute deviation* or *interquartile range (IQR)* in other contexts. The FE exam **usually sticks to range, variance, and standard deviation**. IQR (Q3–Q1) could be mentioned if a question involves percentiles or boxplots, but that's uncommon in Mechanical FE.

- **Empirical Rule (68–95–99.7):** This is a property of normal distributions: ~68% of data lie within 1 standard deviation of the mean, ~95% within 2, ~99.7% within 3 (for a bell curve). It's a handy rule of thumb. If a question gives a bell-shaped distribution's mean and sigma, you might use this rule to estimate probabilities or thresholds. (This verges into probability, but it's a connection worth noting as "adjacent knowledge.")

- **Combining uncertainties:** In some engineering contexts, if you have independent sources of error, the overall standard deviation is the root-sum-square of individual std devs. Just an applied note: e.g., if machine A's cut length varies with σ=1 mm and machine B's with σ=2 mm independently, combined variation is $\sqrt{1^2 + 2^2} = 2.24$ mm. Keep in mind if an exam question gives multiple variability sources.

Special Notes – Calculator Usage: Manually computing variance or standard deviation can be time-consuming if the data set is large.

Calculator tip: Both the TI-36X Pro and Casio fx-115/991 series have a statistics mode. You can input data and then retrieve n, $\bar{x}$, s (sample standard deviation), and σ (population stdev) directly. For example, on the TI-36X Pro, you'd press DATA, enter each value, then press 2ND STAT to see results like $\bar{x}$, Sx (which is s), and σx. Make sure you know which one is which: **Sx corresponds to sample standard deviation (uses $n-1$ in denom)**, while **σx is population stdev (uses n in denom)**. The exam typically expects the sample version unless it's clearly the whole population. If in doubt and not stated, using $n-1$ is safer for an unbiased estimate from a sample. (Also, remember to clear any old data from the calculator's stats registers to avoid mixing data sets!)

Equation Passport – Variance and Standard Deviation

Purpose: Variance and standard deviation indicate the extent to which data values typically deviate from the mean. A large variance implies the data are widely dispersed, whereas a small variance indicates they are closely concentrated near the mean. Standard deviation is just the square root of variance, making it directly comparable to the mean in units.

- **Population Variance:**

$$\sigma^2 = \frac{1}{N}\sum_{i=1}^{N}(X_i - \mu)^2,$$

where N is the number of data points in the population and μ is the population mean.

- **Sample Variance:**

$$s^2 = \frac{1}{n-1}\sum_{i=1}^{n}(X_i - \bar{X})^2,$$

where n is the sample size and $\bar{X}$ is the sample mean.

- **Standard Deviation:**

$$\sigma = \sqrt{\sigma^2}, \qquad s = \sqrt{s^2}.$$

(Simply the positive square root of variance. Use σ for population stdev and s for sample stdev.)

Variables and units:

- X_i = the ith data value. Units: same as data (e.g., °C, mm, N·m).
- μ = population mean, $\bar{X}$ = sample mean. Units: same as data.
- N = population size (total number of points in full population, dimensionless count).
- n = sample size (number of points in sample, dimensionless).
- σ^2, s^2 = variance of population or sample, respectively.

Units: **square of data's units**.
- σ, s = standard deviation of population or sample. Units: same as data (since taking square root of squared units).

Assumptions and scope:

- The formulas above assume you're dealing with a *basic random sample* for s^2. The use of $n-1$ in the sample variance is to ensure an unbiased estimate of σ^2 when the data are sampled from a larger population.

- Data ideally are measured on an interval or ratio scale so differences $X_i - \bar{X}$ are meaningful. Also, variance heavily weights outliers (because of squaring), so normality isn't required but if the distribution is extremely heavy-tailed, variance might be less stable (though still computable).

- The standard deviation s or σ is always taken as the positive square root. (In theory, the square root has a ±, but standard deviation is defined non-negative.)

- **Independence** is only a factor when combining variances from different sources. For a single dataset calculation, you don't need any assumption of independence (that matters if you consider multiple random variables or want statistical properties of s^2).

Limit tests (sanity checks):

- If all data points are identical (say every $X_i = C$), then $X_i - \bar{X} = 0$ for all i. Plugging in: variance $= \frac{1}{n-1}\sum 0^2 = 0$. That makes sense: no spread at all, standard deviation is 0. Always expect variance ≥ 0 (it can never be negative because it's an average of squared terms).

- If data points spread out more, variance increases. For example, compare two small datasets: {5,5,5,5} vs {0,10,0,10}. Both have mean 5. The first has variance 0 (all equal to mean); the second has a noticeable spread. Compute second case sample variance: $s^2 = \frac{1}{3}[(0-5)^2 + (10-5)^2 + (0-5)^2 + (10-5)^2] = \frac{1}{3}[25 + 25 +$

$25 + 25] = \frac{100}{3} \approx 33.3$. Standard deviation $s \approx 5.77$. Indeed the second dataset is more spread out, and the variance reflects that.

- If you only have $n = 1$ data point, note the sample variance formula $s^2 = \frac{1}{n-1}\sum(X_i - \bar{X})^2$ is mathematically not usable (division by zero). This underscores that you can't estimate variability from a single sample point—you need at least n=2 for sample variance. (For population variance, if you truly have just one value in the population, variance is 0 by definition because there's no variation.)

- Units check: After computing variance, remember to take square root for standard deviation if the question asks for it. For instance, if variance $s^2 = 9$ (m^2), then $s = 3$ m. The unit correction by square root is a good mental check that you did that step.

Use vs. sibling measures: Use **standard deviation** whenever you want to express variability in a comprehensible way – it's the go-to measure of spread alongside the mean. For instance, an exam problem might give "mean = 50, standard deviation = 5" and ask something about the distribution; that's directly interpretable (most values are within 5 of 50 if roughly normal).

Use variance when performing calculations that naturally involve variances (sometimes in probability or when adding independent uncertainties, since variances add while standard deviations do not). If a problem involves combining different error sources or requires the intermediate step of summing squared deviations, you might work with variance internally, then take sqrt at the end.

Use range as a quick check or when specifically asked – e.g., "what is the range of the data". Range is also used in some simple quality control charts (like Range charts in Statistical Process Control). However, range alone is not as informative as standard deviation for most quantitative analysis, so it usually appears in straightforward questions (like given min and max, find the difference).

Common exam traps:

- **Mixing up n vs $n - 1$:** The most classic mistake. Remember: if it's a sample and you're asked for standard deviation or variance without more context, use $n - 1$ in the denominator (unbiased sample estimate). The exam might directly say "sample standard deviation," which implies $n - 1$. If they give you an entire small dataset and don't explicitly say it's a sample from bigger population, it's a bit ambiguous – but they often expect the sample formula. If they wanted population values, they might phrase it as "these are the entire population". When in doubt, look at answer choices: a slight difference in whether they divide by n or $n - 1$ will change the result a bit.

- **Forgetting to take square root:** If asked for standard deviation and you compute variance, don't stop there. It's easy to accidentally give s^2 when s was asked.

- **Unit confusion:** As mentioned, variance's units can trip you up. For example, if lengths are in cm, variance is in cm². If a problem gives you variance and asks something in terms of original units, make sure to sqrt it if needed. Conversely, if a result seems off by a factor (like you got 100 instead of 10 for a spread measure), check if you were supposed to square or sqrt something.

- **Using range inappropriately:** Because range uses only min and max, it might not reflect true variability if those extremes are outliers. If a question asks which dataset is more variable and one has a slightly larger range but the other has a much larger standard deviation, the latter is actually more variable overall. Pay attention to what measure the question wants – don't just default to range unless it's specifically the answer target.

- **Rounding errors:** When calculating by hand, carry enough precision especially if data aren't nice. The exam might have a tolerance, but using your calculator's stats function avoids intermediate rounding altogether.

Explanation & Analysis: Let's break down the calculation and meaning of these dispersion measures:

- **Range:** It's the simplest: $R = X_{\max} - X_{\min}$. For example, if the smallest measured torque is 5 N·m and the largest is 9 N·m, the range is 4 N·m. It tells you the full spread. The downside is that if 5 was just one oddball low point, range doesn't tell you that most values might actually be around 9. It gives no insight into how things are distributed between the min and max. Still, if a question asks "what is the range," just do max minus min. It's a one-step calculation.

- **Variance:** This is a bit more involved. The idea is to quantify the *average squared deviation* from the mean. Why squared? Squaring makes all deviations positive and penalizes larger deviations more (so big outliers heavily influence variance). The formula $s^2 = \frac{1}{n-1}\sum(X_i - \bar{X})^2$ can be computed in steps:

1. Find the mean $\bar{X}$.
2. Subtract the mean from each data point to get deviations $(X_i - \bar{X})$. Some will be negative, some positive, and they should sum to zero (that's a check: $\sum(X_i - \bar{X}) = 0$).
3. Square each deviation $(X_i - \bar{X})^2$ (now all values are nonnegative).
4. Sum up those squared deviations.
5. Divide by $n - 1$ (for a sample) or N (for full population). This gives the average squared deviation.

This result is the variance. It's an "average of squares." If variance is large, it means a lot of the X_i were far from the mean.

For example, say our sample data (mm) are: 4, 6, 9, 11. The mean $\bar{X} = 7.5$. Deviations: -3.5, -1.5, +1.5, +3.5. Squared deviations: 12.25, 2.25, 2.25, 12.25 (notice symmetry around the mean). Sum = 29. Divide by $n - 1 = 3$: $s^2 = 9.67$ mm² (variance). Standard deviation $s = \sqrt{9.67} = 3.11$ mm. Interpretation: on average, points are about 3.11 mm away from the mean of 7.5 mm.

One useful algebraic identity for variance (though not often needed explicitly on FE exam) is:

$$s^2 = \frac{1}{n-1}\left(\sum X_i^2 - \frac{(\sum X_i)^2}{n}\right).$$

This can speed up manual calculation if you have $\sum X_i$ and $\sum X_i^2$. But with a calculator, it's usually not necessary to use this formula; the calculator's stats function does it internally. However, if a problem gives you pre-computed sums or already has mean, this identity can be a quick check. (For instance, the exam might give summary stats in a table and expect you to apply them.)

- **Standard Deviation:** Simply the square root of variance. Using the example above, $s = 3.11$ mm tells us a typical

deviation from the mean is about 3.11 mm. Standard deviation is more intuitive because you can say, roughly, "most values are within 1 or 2 standard deviations of the mean" (which ties into the 68–95–99.7% rule for normally distributed data). In practice, if an exam question states a mean and a standard deviation, they might ask how many items fall into a certain range. If we assume a normal distribution, about 95% of items fall in $\mu \pm 2\sigma$. For instance, if a machine produces bolts with $\mu = 50.0$ mm and $\sigma = 0.1$ mm, roughly 95% of bolts are between 49.8 mm and 50.2 mm. That's a small spread—high precision. If another machine had $\sigma = 1.0$ mm, 95% would be between 48.0 mm and 52.0 mm – much wider, potentially unacceptable for tight tolerances.

On the FE exam, when you're asked to compute these, **write down the formula first** (either from memory or by quickly looking it up with the search cues). This anchors your solution. Then plug in values. Watch out for **units** and **rounding**. If intermediate results are needed (like mean first, then variance), keep a few extra decimal places until the end to avoid round-off error, or better, let the calculator do it in one go.

A special consideration: sometimes you may be given summarized data rather than raw data. For example, a problem might say: "Five measurements have a mean of 8 and a standard deviation of 2. Find the variance." Here, you don't need raw data at all – you know variance $s^2 = 2^2 = 4$. Or they might reverse it: give variance and ask for standard deviation (just sqrt it). They could also hide the calculation in a word problem, like describing how consistent or inconsistent something is. Key terms like "standard deviation," "spread," "variance," "fluctuation," "dispersion" all hint at these measures.

Finally, in comparing two datasets, **standard deviation is usually the fairest basis** because it accounts for all data. Range can be deceptive (one unusual value can inflate it). So if a question asks something like "which process yields more consistent results," look at the standard deviations if provided (smaller stdev = more consistent). If only ranges are given, it's trickier, but usually smaller range suggests more consistency *if* sample sizes are similar.

K02.T02.S03 – Confidence Intervals and Margin of Error (Estimates of Mean/Proportion)

Principle Introduction – A **confidence interval (CI)** is a range around a sample estimate that likely contains the true population value. It reflects the **margin of error** in our estimate. If you measure or survey and get a result, you rarely want to claim that the true value is exactly that result—there's uncertainty, especially with small samples. A confidence interval addresses this by giving an upper and lower bound. For example, you might say, "From the sample data, we can say with 95% confidence that the actual mean falls within the range of 75 to 85." That range 75–85 is the confidence interval, and ±5 around the sample mean is the margin of error (half the width of the interval).

On the FE exam, you might be asked to compute a confidence interval for a **mean** or a **proportion** or to interpret one. Typical scenarios: - Given a sample mean, standard deviation, and sample size, find a 95% confidence interval for the population mean. - Given a sample proportion (like 40 successes out of 100 trials), find the confidence interval for the true proportion. - Or qualitatively: understanding that increasing confidence level makes the interval wider (more certainty requires a broader net), and increasing sample size makes the interval narrower (more data pin down the estimate better).

Understanding confidence intervals helps in decision-making: e.g., *"Is this result significantly different from a benchmark?"* If the benchmark lies outside your CI, it's likely a real difference. While hypothesis testing is another topic, confidence intervals are very much linked (an interval that doesn't include a certain value implies a statistically significant difference at that confidence level).

Exam Handbook Search Cues (Not affiliated with or endorsed by NCEES): *confidence interval, margin of error, Z, t-distribution, sample estimate* – In the reference, look for the section on confidence intervals under probability & statistics. The handbook provides formulas for confidence intervals of means (and differences, variances, etc.), along with a table of common Z-values for confidence levels (e.g., 1.9600 for 95%). Keywords like "Zα/2" or "confidence" will jump to those formulas.

Footnotes:

- **Confidence level vs. α:** A 95% confidence level means $\alpha = 0.05$ significance (with 0.025 in each tail if two-sided). In formula terms, you'll use $Z_{\alpha/2} = Z_{0.025} = 1.96$ (from the standard normal table) for 95%. For 90% CI, $\alpha = 0.10$ and $Z_{0.05} = 1.645$. These Z values are in the exam reference—no need to memorize if you can quickly find them, but it helps to *recognize* the common ones (90%, 95%, 99%).

- **When to use t:** If the **sample size is small** (traditionally $n < 30$) and the population standard deviation is unknown, the more accurate approach is to use the **Student's t-distribution** instead of normal. That means using $t_{\alpha/2, n-1}$ critical values and s (sample stdev) in place of σ. The FE exam might not often require computing a t-value (since the handbook has a t-table too), but be aware: if a problem explicitly says "assume normal distribution" and sample is large, you're safe with Z. If sample is tiny and they mention using a t or degrees of freedom, adjust accordingly. Often, though, if an exam problem expects a confidence interval, they either give you σ or a decent sample size so Z can be used.

- **Proportions:** For a proportion $\hat{p} = \frac{\text{\# successes}}{n}$, confidence intervals rely on normal approximation to the binomial. The standard deviation of $\hat{p}$ is $\sqrt{\hat{p}(1-\hat{p})/n}$. This is valid when $n\hat{p}$ and $n(1-\hat{p})$ are both >= 5 or so (to ensure approximate normality). On the exam, if they ask for a CI for a proportion, it's likely in a scenario where this condition holds (like 40 out of 100, not 2 out of 5).

- **Interpretation:** This trips up many – a 95% CI *does NOT* mean "there's a 95% probability the true value lies in this specific interval." Rather, it means if we repeated the sampling many times, 95% of the intervals we compute would contain the true value. In practice, we treat it informally as "we're 95% sure the true value is in [L, U]." The exam may test your understanding by giving a statement and asking if it's a correct interpretation.

Remember: the confidence is about the **process**, not a probability for the fixed true value. However, it's unlikely they'll get that philosophical at FE level; more likely they'll focus on calculation or straightforward understanding (like higher confidence = wider interval).

- **Margin of Error (MoE):** This is the "±" part of a confidence interval. If you see a poll result like "60% ± 3% at 95% confidence," the margin of error is 3%. It corresponds to $Z_{\alpha/2} \times$ (standard error). It's essentially half the width of the confidence interval. It grows with higher confidence and shrinks with larger n.

Variations: - We primarily deal with two kinds of confidence intervals: one for **means** and one for **proportions** (for single samples). There are formulas for differences between means, differences between proportions, and for variances, but those are usually beyond the scope of a quick FE question unless it explicitly ventures there. If needed, the reference has them (like "Confidence interval for difference of two means" if such a question arises).

- **One-sided vs Two-sided:** All the discussion here assumes two-sided intervals (we capture uncertainty on both sides). One-sided confidence bounds (like "upper 95% confidence bound") exist, but unless specifically asked, assume two-sided (i.e., the classic "between A and B" interval).

- **Sample Size determination:** Sometimes, you might be asked how large n should be to achieve a desired margin of error. For a mean, if you want margin E at confidence $1-\alpha$ and you have an idea of σ, the formula rearranges to $n = \left(\frac{Z_{\alpha/2}\sigma}{E}\right)^2$. For proportion, $n = \hat{p}(1-\hat{p})\left(\frac{Z_{\alpha/2}}{E}\right)^2$ (worst case, when $\hat{p} \approx 0.5$, use 0.25 for $\hat{p}(1-\hat{p})$ if not given a prior estimate). This is just inverted use of the CI formula solving for n. If the exam asks something like "to cut the margin of error in half, how much must the sample size increase?", know that margin of error shrinks with sqrt of n (e.g., to halve MoE, you need four times the samples).

- **Z vs t nuance:** If using a t-value for small samples, note degrees of freedom = $n-1$. The t critical value will be larger than Z for the same confidence when n is small (reflecting more uncertainty). As $n \to \infty$, t approaches Z. Usually, for n≥30, Z is a good approximation.

Special Notes – Using Tables and Calculators:

The exam will likely provide a **Z-value table** (or a small summary of critical values) in the reference. As seen in the handbook, common ones are listed. You could memorize a few: - 90% CI → $Z_{0.05} = 1.645$ - 95% CI → $Z_{0.025} = 1.960$ - 99% CI → $Z_{0.005} = 2.576$ (often rounded 2.58). But if you forget, quickly search the handbook PDF for "Confidence Interval" or scan the provided fractiles table. Calculators like the TI-36X Pro can compute some statistical distributions, but on exam day it's faster to use provided values than to try to invert the normal CDF on the calculator (which is not straightforward on the allowed models).

Also, be mindful: your calculator's statistics functions won't directly give you a confidence interval; you have to compute it. But they can give you $\bar{X}$ and s from data. So use them to get those, then do the CI formula manually. There's no "one-button" CI function on these calculators.

Equation Passport – Confidence Interval for a Mean (Normal Distribution)

Definition: A confidence interval for the population mean gives a range $[L, U]$ computed from sample data, such that if the sampling were repeated many times, a certain percentage (the confidence level) of those intervals would contain the true mean. For a **large sample or known variance** (normal Z-based interval):

$$[L,\ U] = \left[\bar{X} - Z_{\alpha/2}\frac{\sigma}{\sqrt{n}},\quad \bar{X} + Z_{\alpha/2}\frac{\sigma}{\sqrt{n}}\right].$$

The quantity added/subtracted, $Z_{\alpha/2}\frac{\sigma}{\sqrt{n}}$, is the **margin of error**.

Variables:

- $\bar{X}$ = sample mean (our point estimate of the true mean, units same as data).
- σ = population standard deviation. *(If σ is unknown, substitute the sample standard deviation s. For large n, this is fine; for small n, use t distribution instead of Z.)*
- n = sample size.
- $Z_{\alpha/2}$ = critical value from standard normal distribution for the desired confidence level. For example, for 95% confidence, $\alpha = 0.05$ so $Z_{0.025} \approx 1.96$. This factor scales the standard error to the desired confidence.

Assumptions:

- The data should be drawn from a population that is approximately normal **or** the sample size n is large (Central Limit Theorem ensures $\bar{X}$ is ~normal for large n).
- If using $Z_{\alpha/2}$, either the population standard deviation σ is known (rarely true in practice, but sometimes given in textbook scenarios) or n is sufficiently large to justify using s in place of σ. If n is small and σ unknown, use $t_{\alpha/2,n-1}$ which will give a wider interval.
- The sample is random and representative of the population (so the interval is meaningful for the population in question).

Limit behavior:

- As $n \to \infty$, the margin of error $Z_{\alpha/2}\frac{\sigma}{\sqrt{n}} \to 0$. A very large sample pins down the mean very tightly (interval collapses towards μ). In the limit of infinite data, you'd know the mean exactly.
- As confidence level increases (say from 95% to 99%), $Z_{\alpha/2}$ grows (1.96 to 2.576), so the interval widens. **Higher confidence → wider interval.** This makes sense: to be more confident, you have to cast a wider net.
- If the data itself has more variability (larger σ), the interval widens linearly with σ. More scatter in data means more uncertainty in estimating the mean.
- If $n = 1$, technically you can't form a two-sided interval unless you assume distribution (one point doesn't give a range of likely means—you'd need to use t with 0 degrees of freedom, which is not defined). So you always need $n > 1$ to have a meaningful confidence interval for a mean.
- **Use vs. siblings:** Use this formula for **single-sample mean** questions. If you have two samples and need to compare means, there are different formulas (which involve combining variances). For proportions, use the analogous proportion formula (see below). If you're dealing with a **total** or sum, you might convert it to a mean by dividing (e.g., total = mean * n, so interval for total would be interval for mean times n). In general, confidence intervals are preferred over just quoting the estimate alone when you need to convey precision. If an exam question asks, "which is the better estimate," the one with the narrower confidence interval (at same confidence) is better (more precise).

Common exam traps:

- **Forgetting $\sqrt{n}$ in the denominator:** The standard error for the mean is $\sigma/\sqrt{n}$. It's a very frequent mistake to omit the sqrt or the n entirely. Always recall that averaging reduces variability by factor of $1/\sqrt{n}$. For example, if $\sigma = 10$ and $n = 4$, the standard error is 5; if you mistakenly used $\sigma/n = 2.5$ or forgot n giving 10, you'd be way off.
- **Using wrong Z value:** Ensure you match the confidence level to the correct critical value. Sometimes exam answers will include a wrong option that corresponds to using, say, 1.645 instead of 1.96 or vice versa. Keep the common ones straight: 90% → 1.645; 95% → 1.96; 99% → 2.576. If unsure, look it up in the provided table.
- **Interpreting the interval incorrectly:** As noted, don't say "95% chance the true mean is in our computed interval" in a theoretical sense. A subtler test could be: they might present several statements about a CI and ask which is valid. The safest interpretation: "We are 95% confident the true mean lies between L and U" is acceptable wording. Incorrect would be "95% of data lie between L and U" (that's about prediction intervals or distribution coverage, not what a CI means).
- **Margin of error vs interval endpoints:** If a question specifically asks for "margin of error," don't give the full interval. For example, if $\bar{X} = 50$ and you found a 95% CI [45, 55], the margin of error is 5 (not 45 or 55). It's the amount added/subtracted, not the bounds themselves.
- **Rounding**: If using a Z or t from a table, be cautious about rounding too early. It's best to use the full precision provided (e.g., use 1.960, not 1.9). The exam may have a small tolerance; giving answers to at least 2-3 significant figures is usually safe.

Equation Passport – Confidence Interval for a Proportion

Definition: For a sample proportion $\hat{p}$ (fraction of successes in n trials), a confidence interval provides a range likely to contain the true population proportion p. Assuming a large sample so the normal approximation holds:

$$[L,\ U] = \left[\hat{p} - Z_{\alpha/2}\sqrt{\frac{\hat{p}(1-\hat{p})}{n}},\quad \hat{p} + Z_{\alpha/2}\sqrt{\frac{\hat{p}(1-\hat{p})}{n}}\right].$$

Variables:

- $\hat{p}$ = sample proportion = $\frac{\text{\# of "successes"}}{n}$. (For example, if 45 out of 100 respondents say "yes," then $\hat{p} = 0.45$.)
- n = sample size (number of trials or individuals in sample).
- $Z_{\alpha/2}$ = same critical Z as for means, depending on confidence.
- The standard error here is $\sqrt{\frac{\hat{p}(1-\hat{p})}{n}}$, which is the estimated standard deviation of the sample proportion (derived from binomial distribution's variance $p(1-p)$).

Assumptions:

- The sample size is large enough for the normal approximation to the binomial to be valid. A common rule: $n\hat{p} \geq 5$ and $n(1-\hat{p}) \geq 5$. If this holds, the distribution of $\hat{p}$ is roughly normal.
- The sampling is random. For surveys, also ideally n is much smaller than the population (or use finite population correction if not, though FE usually neglects that unless stated).
- If the sample size is too small or $\hat{p}$ is extreme (very close to 0 or 1), this interval can be inaccurate. But the FE exam will likely avoid those edge cases or expect you to use the formula regardless, unless it specifically checks understanding of conditions.

Limit behavior:

- As n increases, margin of error shrinks with $1/\sqrt{n}$ as well. With a huge sample, you can estimate a proportion very precisely.
- The worst-case margin of error for a given n occurs when $\hat{p} = 0.5$ (because $\hat{p}(1-\hat{p}) = 0.25$ is maximum at 0.5). That's why pollsters sometimes use 0.5 if they want a conservative sample size estimate (it gives the largest required n for a desired MoE).
- If $\hat{p} = 0$ or 1.0, the formula gives 0 under the square root, so CI would degenerate to a point [i.e., 0 to 0 or 1 to 1]. In reality, a 100% or 0% sample still has uncertainty if n isn't infinite. (In those extreme cases, a better method is using a plus-four or other adjustment, but that's beyond our needs; just know the normal CI isn't good at extremes with small n).
- **Use vs. siblings:** Use this for single proportion estimation. If comparing two proportions, there are analogous formulas (and hypothesis tests) but typically outside the scope of FE unless clearly prompted. If a question asks something like "The survey result is 30% with a margin of error of 5%. What is the confidence interval?" you'd answer "[25%, 35%]". Conversely, if they give an interval, you might extract $\hat{p}$ as the midpoint and margin as half the width. Always double-check the context: proportion questions might appear in topics like quality control (e.g., fraction of defective parts).

Common exam traps:

- **Using $\sigma/\sqrt{n}$ instead of the correct proportion formula:** Don't treat a proportion like a mean without adjusting. The "sigma" for a proportion is $\sqrt{p(1-p)}$. If you use the wrong formula, results will be inconsistent.
- **Plugging p instead of $\hat{p}$:** In practice we don't know p (that's what we're estimating!). So we use $\hat{p}$ inside the sqrt. This is an important detail: the formula uses the sample's own proportion to approximate the standard error. If $\hat{p}$ is far from 0.5, the margin gets smaller. If you mistakenly used 0.5 always, you'd get an overly conservative interval unless $\hat{p}$ is indeed 0.5.
- **Interpreting proportion CIs**: Similar issues as with mean. Don't confuse it with saying "95% of individuals fall in this range" – that doesn't apply because proportion is just one number, not a distribution of data. The CI is about our confidence in that one fraction.
- **Percentage vs decimal:** Be clear if the question states percentages. If $\hat{p} = 0.32$ (32%), and margin is 0.05 (5 percentage points), an answer might be best given as 27% to 37% rather than 0.27 to 0.37, depending on context. Just present it in a straightforward manner.
- **Rounding**: If dealing with percentages, keep enough decimal places through calc to not round off error too much. Typically give the interval to one more decimal than the data given (unless it's a nice round number).

Explanation & Analysis:

Bringing it together, constructing a confidence interval is like saying: *estimate ± (a cushion for uncertainty)*. The "cushion" (margin of error) is bigger when: - You choose a higher confidence level (hence a bigger Z or t multiplier). - Your data are more variable (higher σ or s, or for proportions a p near 0.5). - Your sample size is smaller (since divisor √n is smaller).

For example, consider a practical scenario: You measure the yield strength of 9 samples of a new alloy and get a mean of 450 MPa with a sample standard deviation of 30 MPa. If asked for a 95% CI for the true mean strength, since n=9 (which is a bit small), you might use t with df=8. But suppose for simplicity (or if the exam says assume normal with known σ) you use Z. The standard error = 30/√9 = 10 MPa. For 95%, Z=1.96. Margin = 1.96*10 = 19.6 MPa. So CI is [430.4, 469.6] MPa. We'd say: we're 95% confident the true mean strength is about 430 to 470 MPa. If we wanted higher confidence, say 99%, Z=2.576, margin = 25.76 MPa, CI about [424, 476] – wider. If we tested more samples, say n=36 instead, standard error becomes 5 (30/√36) MPa, and 95% CI would tighten to 450 ± 9.8 (that's [440.2, 459.8] MPa). More data, narrower interval.

For a proportion example, imagine the exam gives: "In a survey of 100 machined parts, 5 were defective. Compute a 90% confidence interval for the true proportion of defectives." Here $\hat{p} = 0.05$. For 90% CI, Z=1.645. Standard error ≈ √[0.05*0.95/100] = √(0.000475) = 0.0218 (2.18%). Margin = 1.645*0.0218 ≈ 0.0359 (3.59%). So CI is 0.05 ± 0.0359 = [0.0141, 0.0859], or about [1.4%, 8.6%]. We'd conclude the true defective rate could be around 1–9% with 90% confidence. Notice the asymmetry: we got 5% in sample, but the CI isn't ±3.59% exactly symmetric in terms of difference from 5 (because of rounding, but effectively yes it is symmetric around 5% in calculation). If we had gotten 50 out of 100, margin would be bigger in absolute terms because p=0.5 gives more variance.

In summary, **confidence intervals** turn single-value estimates into a range to account for sampling uncertainty. On the FE, it's mostly plug-and-chug once you identify the right formula. The critical part is recognizing which formula to use (mean vs proportion, Z vs t) and doing the algebra carefully. After computing, interpret it in context: if the question asks something like "does this suggest the process meets the target value of X?", you check if X lies in your interval. If not, that's evidence it might differ.

Topic 03 - Expected Value in Decision Making

Topic Introduction – Why It Matters: Expected value is the theoretical long-run average outcome of a random process. In FE Mechanical Exam problems, you'll often need to determine this "weighted average" of possible results to make informed decisions. This topic is crucial for questions where you must **calculate an expected outcome** (like an average cost, time, or yield) or **compare options** (choosing the design or investment with the highest expected payoff). On exam day, expected value problems tend to be straightforward if you recognize the pattern: multiply each outcome by its probability and sum them up. Mastering this concept ensures you can quickly solve probability questions and apply a solid decision-making criterion under uncertainty.

K02.T03.S01 – Definition of Expected Value (Discrete & Continuous Random Variables)

Principle (Intuition & Definition): Expected value (also called **expectation** or **mean**) represents the balance point of a random variable's distribution. It is defined as a probability-weighted average of all possible values:

- For a **discrete** random variable, the expected value is found by summing each outcome value multiplied by its probability. In other words, add up all x-values, each weighted by how likely it is.
- For a **continuous** random variable, the expected value is the integral of x times its probability density over all possible values (essentially the continuous analog of the weighted sum).
- The expected value $\mathbb{E}[X]$ gives a single number that characterizes the "center" of the distribution – it's what you expect **on average** if the random experiment is repeated many times.
- This concept is fundamental in decision making: it allows engineers to compare different scenarios by their average outcomes, **assuming a risk-neutral perspective** (favoring the highest average result).

Equation Passport: Expected Value of a Random Variable – computes the mean outcome based on a given probability distribution (the theoretical average value of X).

Name and purpose: Expected Value – calculates the long-run average or mean of a random variable's possible values, weighted by probability.

Professional equation(s):

– *Discrete case:* $E[X] = \sum_i x_i \; P(X = x_i)$, where the sum runs over all possible outcomes x_i.
– *Continuous case:* $E[X] = \int_{-\infty}^{\infty} x \; f(x)\, dx$, where $f(x)$ is the probability density function.

(Both formulas are equivalent definitions of the expectation $\mathbb{E}[X]$ *for discrete and continuous variables, respectively.)*

Variables and units:

- X: the random variable of interest (units depend on context, e.g. dollars, seconds, items, etc.)
- x_i: a specific possible value of X (same units as X)
- $P(X = x_i)$: probability that X equals x_i (dimensionless, since probability has no units)
- $f(x)$: probability density function of X for continuous cases (units: 1/[units of X]; ensures $f(x)\, dx$ is dimensionless probability)
- $E[X]$ (also denoted μ_X): expected value (mean) of X (same units as X; often μ is used to represent a distribution's mean)

Assumptions and scope:

- The summation or integration is taken over **all** possible values of X. For discrete distributions, all outcomes x_i are included; for continuous distributions, integrate over the full range where $f(x)$ is nonzero.
- The probabilities must be valid (nonnegative and summing to 1 for discrete, or $f(x)$ must integrate to 1 for continuous distributions).
- We assume the expected value **exists** (the sum/integral converges to a finite number). All common distributions in the FE exam have a well-defined finite mean.
- This formula gives a measure of central tendency for the distribution – it's effectively the "center of mass" of the probability distribution. (It does **not** account for variability or spread – that's what variance and standard deviation are for.)

Limit checks (sanity tests):

- If one outcome has probability 1 (a sure thing), $E[X]$ equals that outcome. (Consistency: if X is always 5, then $E[X] = 5$.)
- If the distribution is symmetric about some value, the expected value lies at that symmetry center. *For example, a fair die is symmetric about 3.5, which indeed equals* $E[X]$ *for a uniform 1–6 outcome.*
- If all outcomes are equally likely (uniform discrete distribution), $E[X]$ simplifies to the simple arithmetic average of the outcomes. (For instance, for outcomes $\{a, b\}$ with 50% each, $E[X] = \frac{a+b}{2}$.)
- **Use vs. sibling concepts:** Use the expected value formula whenever you need the **average outcome** given a probability distribution. It is the correct tool instead of a plain arithmetic mean when outcomes have *unequal probabilities*. (If probabilities are equal, expectation and arithmetic mean coincide.) **Do not confuse** expected value with other metrics like median or mode – those answer different "typical value" questions. Also, if you have sample data points, the *sample mean* calculation is analogous (sum of values divided by count), but here we're dealing with a theoretical distribution where probabilities might not be equal. In short, use $E[X]$ to

aggregate outcomes weighted by likelihood, rather than just averaging raw values without weights.

Common exam traps:

- **Omitting the probability weights:** A frequent mistake is to add up the outcomes and divide by the number of outcomes (simple average) even when probabilities are not equal. Always multiply each value by its probability before summing.
- **Unit mix-ups:** Remember that probabilities are unitless and $E[X]$ carries the **same units as** X. For example, if X is a load in kN, $E[X]$ will be in kN. If probabilities are given in percent, convert them to decimals (e.g. 25% → 0.25) before calculations.
- **Continuous confusion:** For continuous distributions, don't treat $f(x)$ as if it were a direct probability of x. You must integrate $xf(x)\,dx$ over the range. A common error is to plug x into $f(x)$ and think that's the contribution – instead, you need the area under the density curve weighted by x.
- **Mixing formulas:** Avoid confusing the expected value formula with the variance formula or others. For example, the variance uses $E[X^2] - (E[X])^2$; if a problem only asks for $E[X]$, don't overcomplicate it by computing variance or higher moments.
- **Interpretation slip-ups:** $E[X]$ is *not* necessarily a value X can actually take. It can be a number that no single outcome equals (e.g. $E[\text{roll of a die}] = 3.5$, even though 3.5 is not a face on the die). So don't answer with "no result" just because the expected value is a fractional or otherwise unattainable number – it's an abstract average.

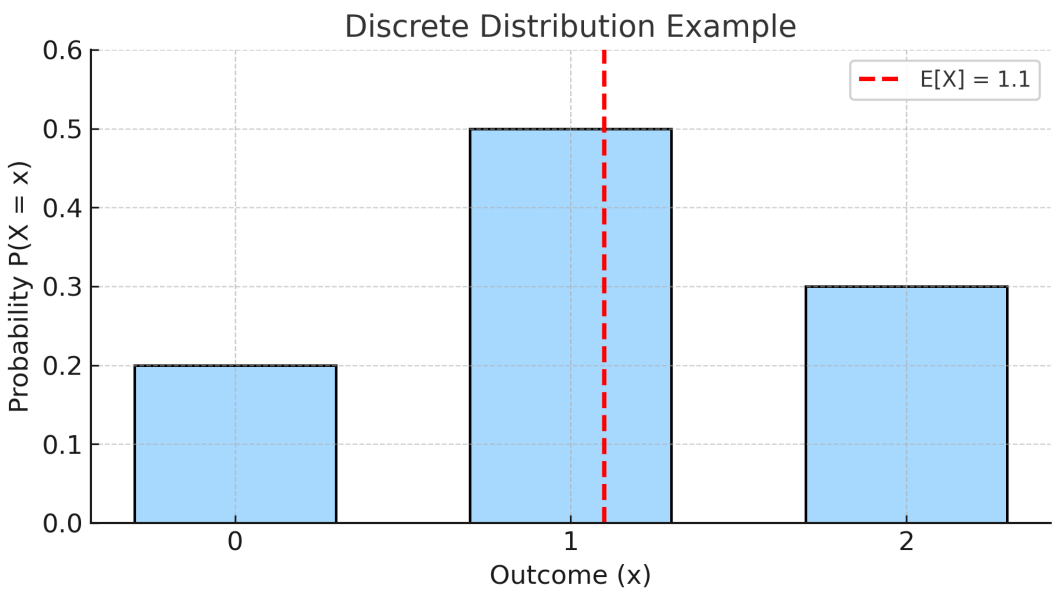

Figure: A simple discrete probability distribution with three possible outcomes (0, 1, and 2). The height of each bar indicates that outcome's probability $P(X = x)$. The dashed line marks the expected value $E[X] = 1.1$. This value is the "balance point" of the distribution – the weighted average of outcomes (0, 1, 2) by their probabilities (0.2, 0.5, 0.3 respectively). In general, the expected value will lie between the minimum and maximum outcomes; here, with outcomes ranging from 0 to 2, the expectation 1.1 falls in between as expected.

Exam Handbook Search Cues (Not affiliated with or endorsed by NCEES): *expected value; expectation; mean; weighted average (In the exam handbook's index or search function, look for these terms to quickly find the formula for expected value if needed.)*

Footnotes:
- *Units Consistency:* Always carry units through your calculation. For example, if X is measured in m (meters), then each term $x_i P(X = x_i)$ has units m, and the sum $E[X]$ will be in m as well. This helps catch mistakes – if you end up with an expected value in odd units (like "meter-probabilities"), you've done something wrong in the arithmetic.
- *Notation:* $\mathbb{E}[X]$ and $E(X)$ are both common notations for expected value. The exam handbook might use a stylized EX or the symbol μ (mu) to denote the mean. These all represent the same concept.
- *Scope:* The FE exam expects you to know the basic idea of expected value and how to compute it for standard cases. You generally won't need to derive complicated integrals on exam day – most continuous expectation problems involve well-known distributions (where means are known or easy to integrate) or provide the PDF in a simple form. Focus on applying the formula correctly rather than re-deriving proofs.

Variations and Related Forms:

- **Discrete vs. Continuous:** The definition of expectation is fundamentally the same formula expressed as a sum or an integral. Be comfortable recognizing both forms. If a problem gives a probability mass function (PMF) with specific values and probabilities, use the summation form. If given a probability density function (PDF), set up the integral $\int xf(x)\,dx$ over the relevant range.

- **Expectation of a Function:** In some cases, you might need $E[g(X)]$ for some function g. The formula extends naturally: $E[g(X)] = \sum g(x_i)P(X = x_i)$ (discrete) or $E[g(X)] = \int_{-\infty}^{\infty} g(x)f(x)\,dx$ (continuous). For example, the formula for variance uses $g(X) = X^2$. While the FE exam may not ask you to derive such formulas from scratch, understanding this helps you navigate to related formulas (like $E[X^2]$ for variance calculations).

- **Common distributions' means:** It's helpful to remember the expected values of a few standard distributions: for instance, a uniform distribution on $[a, b]$ has $E[X] = \frac{a+b}{2}$; a binomial distribution $\text{Bin}(n, p)$ has $E[X] = np$; an exponential distribution with rate λ has $E[X] = 1/\lambda$; a normal distribution $N(\mu, \sigma)$ has $E[X] = \mu$. These results all come from the general formula, but knowing them can save time.

- **Synonyms:** Expected value is interchangeably called **mean** (particularly in the context of distributions) or **mathematical expectation**. In an exam question, if they mention "the mean of a random variable" or ask for the "expected payoff" or "weighted average outcome," they're referring to $E[X]$. Recognize these phrasings so you apply the right formula.

Special notes (for exam calculation): The arithmetic for expected value is usually straightforward (multiply and add). With an FE-approved calculator, you'll just perform these basic operations. If you have many terms, be careful to avoid entry errors: it can help to sum in parts or use the memory feature for running totals. There's no need for programming or complex calculator functions here – just ensure you include every term once. Also, double-check that probabilities sum to 1 (or that you integrated the correct limits in continuous cases) if something feels off; a quick sum of probabilities can verify you haven't missed any outcome.

Explanation & Analysis: The expected value formula is fundamentally about **weighing outcomes by likelihood**. Think of it this way: if you could repeat the random scenario thousands of times and average the results, that average would approach $E[X]$. On the FE exam, a typical use-case is computing an average outcome such as an average cost, length, or efficiency given a probability distribution of scenarios. For example, *"Given a table of possible demand levels and their probabilities, what is the expected demand?"* – here you'd multiply each demand level by its probability and sum up. Another example: *"An investment returns $100 with 40% probability and $0 with 60% probability. What is the expected return?"* You would calculate $100(0.4) + 0(0.6) = \$40$. This single number $40 represents the **average return** per investment in the long run, and can guide decision-making (e.g. comparing investments by their expected values).

To compute a discrete expected value step-by-step on exam day, follow a simple **weighted-sum procedure**:

1. **List outcomes:** Write down each distinct outcome x_i of the random variable and identify its probability $P(X = x_i)$. For instance, if a quality inspection finds 0 defects (80% chance), 1 defect (15% chance), or 2 defects (5% chance), list those cases.
2. **Multiply value by probability:** For each outcome, calculate the product $x_i \times P(X = x_i)$. This gives the contribution of that outcome to the overall average. Using the defects example, you'd compute $0 \times 0.80 = 0$, $1 \times 0.15 = 0.15$, $2 \times 0.05 = 0.10$.
3. **Sum the contributions:** Add up all those products: $0 + 0.15 + 0.10 = 0.25$. This sum is $E[X]$. In our example, $E[\text{defects per batch}] = 0.25$. This means on average, a batch has 0.25 defects (of course, you can't have a quarter of a defect in reality, but as an expectation over many batches, it makes sense).

Each term in the sum $x_i P(X = x_i)$ can be interpreted as "x_i weighted by how frequently it occurs." The summation effectively blends the outcomes according to their likelihood. If an outcome has a higher probability, it pulls the average more strongly in its direction (much like a heavier weight on one side of a balance).

For continuous random variables, the idea is similar but uses calculus: $E[X] = \int xf(x)dx$ sums up (integrates) infinitely many tiny outcome slices x weighted by $f(x)$. In practice, you'd plug in the given density function and integrate over the allowed range of x. For example, if X has a continuous uniform distribution from 2 to 4, $f(x) = 0.5$ on [2,4]; computing $E[X] = \int_2^4 x\,(0.5)dx$ will yield 3, which matches the midpoint $(2 + 4)/2$. If integration isn't your strong suit, remember that for well-known continuous distributions like uniform, normal, or exponential, you likely *remember or can quickly derive* the mean without heavy calculations on the exam.

In summary, expected value is a straightforward but powerful tool: it gives you the **average outcome** in one number. In decision-making contexts, this helps to evaluate alternatives by comparing their expected outcomes. Keep in mind, though, that expected value doesn't tell the whole story about risk or variability – it's possible two options both yield $100 expected profit, but one is a sure $100 and the other is 50% chance $200 or 50% chance $0. They have the same expectation, so additional risk considerations (outside pure expected value) would differentiate them. However, for the FE Mechanical Exam, you typically won't delve into risk aversion or variance in decision-making; you'll use expected value as a criterion assuming a neutral stance toward risk (i.e. higher expected value = better, in the context of a single decision or a repeatable event).

K02.T03.S02 – Linearity of Expectation (Sums of Random Variables & Decision Criteria)

Principle (Intuition & Property): *Linearity of expectation* is the property that the expectation operator is **linear** – meaning the expected value of a sum (or weighted sum) of random variables is just the sum (or weighted sum) of their individual expected values. This greatly simplifies calculations:

- **Always add means for sums:** If you have multiple random contributions to a total, you can find the total's expected value by **adding up each contribution's expected value**. For example, if $Y = X_1 + X_2$, then $E[Y] = E[X_1] + E[X_2]$. If you scale a random variable by a constant, the expectation scales by the same constant: $E[aX] = a\,E[X]$ for any constant a.
- **No independence needed:** Unlike some other properties in probability, linearity of expectation does **not** require the random variables to be independent. It holds unconditionally. Whether X_1 and X_2 are related or not, $E[X_1 + X_2] = E[X_1] + E[X_2]$. This is purely an algebraic fact about expectations.
- **Decision-making context:** In practical terms, this means you can evaluate complex expected outcomes by parts. If a total cost is composed of various random sub-costs, you can average each part and sum them. If a performance

metric is a combination of factors, you can average each factor's contribution. This linear additivity is often used in **engineering economics and risk analysis** – for instance, calculating an expected total profit = expected revenue − expected expenses, or expected project duration = sum of expected durations of each task (assuming certain conditions).

- **Evaluate alternatives easily:** Linearity supports decision criteria like **"choose the option with the highest expected value."** You can break down each option's outcome into pieces, find the expectation of each piece, and combine them. It's often easier than attempting to derive the full distribution of outcomes for each option.

Equation Passport: Linearity of Expectation – allows quick computation of the expected value of a sum or linear combination of random variables by operating on each component separately.

- **Name and purpose:** Linearity of Expectation – calculates the expectation of a sum (or weighted sum) of random variables by summing their expectations. It's used to simplify finding mean outcomes for combined processes or multi-part systems.
- **Professional equation:** For any random variables $X_1, X_2, \dots, X_n$ and any constants (scalars) $a_1, a_2, \dots, a_n$:

  ** $E[a_1X_1 + a_2X_2 + \cdots + a_nX_n] = a_1\,E[X_1] + a_2\,E[X_2] + \cdots + a_n\,E[X_n]$.**

  In particular, $E[X + Y] = E[X] + E[Y]$, and $E[c] = c$ for any constant c. *(This formula defines the linearity property: the expectation operator $E[\cdot]$ distributes over addition and allows constants to be factored out.)*

Variables and units:

- $X_1, X_2, \dots, X_n$: random variables being combined (each may have different distributions; units can vary but typically you combine commensurate quantities)
- $a_1, a_2, \dots, a_n$: fixed constants (coefficients) multiplying each random variable. These might be dimensionless multipliers or have units that, when multiplied by X_i's units, give a common unit for all terms. For example, if X is in \$, a coefficient $a = 0.8$ (dimensionless) might represent a fraction of revenue, or $a = 5$ could be a scalar factor; if combining different unit quantities, each coefficient should include any conversion factor to get terms to the same unit.
- $E[X_i]$: expected value of X_i (same units as X_i; each term $a_iE[X_i]$ shares the common unit of the sum Y)
- Y *(optional notation):* Sometimes it's helpful to define $Y = a_1X_1 + \cdots + a_nX_n$ as the combined random variable of interest. Then the formula reads $E[Y] = a_1E[X_1] + \cdots + a_nE[X_n]$. $E[Y]$ has the same units as each a_iX_i term (the output unit of the linear combination).

Assumptions and scope:

- **Universally valid:** No special conditions like independence or identical distribution are required. This linearity holds for *any* random variables, provided the individual expectations $E[X_i]$ exist.
- **Finite expectations:** Each $E[X_i]$ should be finite for the formula to be applicable. If any component has an infinite or undefined expectation, then the sum's expectation might be undefined as well. In typical FE exam scenarios, all given expectations are finite.
- **Includes constants:** Treat a constant term as a random variable that always takes that value. For example, if you have a fixed offset $+C$ in your sum, note that $E[C] = C$. The formula inherently covers this since constants factor out: $E[C] = C$. So linearity also implies $E[X + C] = E[X] + C$.
- **Scope of use:** This property is often used in scenarios like: computing expected total cost (sum of various cost components), expected output of a production line (sum of different station outputs), or expected value in decision trees (summing branches' outcomes). Whenever breaking a problem into parts, you can find each part's mean and add them.

Limit checks:

- **Coefficient 0:** If any coefficient $a_j = 0$, that term contributes nothing, and indeed the formula gives $0 \cdot E[X_j] = 0$. This is consistent: a term with zero weight doesn't affect the total expectation.
- **Single term:** If there's just one random variable ($n = 1$), the formula reduces to $E[a_1X_1] = a_1E[X_1]$. This is a sanity check: scaling a variable's outcomes scales its mean by the same factor. For example, if $Y = 5X$, obviously the average of Y should be 5 times the average of X. Linearity confirms that.
- **Sum of two:** For two variables, $E[X_1 + X_2] = E[X_1] + E[X_2]$. If, say, X_1 tends to be around 10 and X_2 around 3 on average, then $X_1 + X_2$ will be around 13 on average. The linearity check matches intuition that means add up.
- **Opposite changes:** If one variable tends to be high when another is low, or any dependency between them, it doesn't matter – their expectations add regardless. For instance, even if X_1 and X_2 are perfectly negatively correlated, you still get $E[X_1 + X_2] = E[X_1] + E[X_2]$. (Dependency will, however, affect the **distribution** and **variance** of the sum, but not the mean.)
- **Use vs. sibling equations:** Use the linearity of expectation **instead of deriving the full distribution** of a sum whenever you only need the mean. For example, to find the expected total of two random loads, you do *not* need to convolute their distributions or assume normality – simply add their expected values. This is in contrast to finding the **variance** of a sum, where you **do** need to consider correlations or independence. A common confusion is mixing up linearity of expectation with linearity of variance: remember, **expectations always add**; **variances add only if variables are independent** (and even then it's the variances that add, not the standard deviations). So, use this expectation property freely for sums. Another "sibling" concept is the **expected value of a product** $E[XY]$ – **do not** assume $E[XY] = E[X]E[Y]$ unless you know X and Y are independent (that's a different rule). In summary, to compute $E[X + Y]$ or $E[aX + bY]$, linearity is your friend; but for $E[XY]$ or other nonlinear combinations, you need additional info or different formulas.

Common exam traps:

- **Unnecessary work:** Sometimes students faced with a sum of random quantities feel they must find the entire probability distribution of the sum. This can be complicated (convolutions, etc.). Often, the exam only asks for the expected total, in which case *just add the expectations*. Don't waste time deriving what you don't need.
- **Forgetting constants:** If a quantity has both random and deterministic parts (e.g. a cost estimate = fixed base cost + random extra cost), don't forget to include the fixed part in the expectation. Linearity handles this by $E[\text{fixed} + \text{random}] = \text{fixed} + E[\text{random}]$. A common slip is to compute the mean of the random part and give that as the answer, neglecting an always-present offset. Always ask: is there a constant term that should be added?
- **Independence confusion:** As emphasized, you do *not* need independence for expectation to add. A trap is thinking "X and Y are dependent, so I can't add their expectations." Wrong – you can. No matter how X and Y might influence each other, $E[X+Y] = E[X] + E[Y]$. The exam may implicitly test this understanding by giving variables that are obviously dependent (like one is "remaining life" and another is "used life" of a component, which sum to a constant) and expecting you to still add their means correctly.
- **Misusing linearity on non-linear operations:** We mentioned this, but it bears repeating: linearity applies to sums, not products or other functions. A pitfall is assuming something like $E(XY) = E(X)E(Y)$ in general (not true unless independent) or $E[X^2] = (E[X])^2$ (generally false). When you see addition or scalar multiplication, you're safe to distribute $E[\cdot]$; if you see multiplication or powers, be cautious and recall the correct formulas or conditions.
- **Sign errors in subtraction:** If the combination involves subtraction, e.g. $Y = X_1 - X_2$, linearity still applies: $E[Y] = E[X_1] - E[X_2]$. Ensure you carry any minus signs through. A minor arithmetic trap is to forget a negative, especially if you plug in numbers: e.g. if $E[X_1] = 5$ and $E[X_2] = 7$, then $E[X_1 - X_2] = 5 - 7 = -2$. It's straightforward, but easy to slip if rushing.

Exam Handbook Search Cues (Not affiliated with or endorsed by NCEES): *linearity of expectation; expected value (of sum); additivity of expected values*
(The exam reference material might not explicitly label "linearity," but searching for "expected value" and related terms can lead you to any listed properties. Often the rule $E[X+Y] = E[X] + E[Y]$ is stated near the definition of expected value or in a section on combined random variables.)

Footnotes:

- *No independence required:* This cannot be stressed enough – independence is irrelevant for adding expectations. Even if a problem mentions events or variables that are statistically dependent, it does not hinder computing the expected sum via linearity. Don't overthink dependencies when asked for a sum's mean, unless the problem specifically involves something like $E[XY]$ or variance.

- *Combining unlike units:* Linearity only makes sense if the terms you're adding are commensurate. If you add X (in dollars) and Y (in hours), the "expected sum" $E[X+Y]$ isn't meaningful because dollars + hours isn't a single quantity. The exam won't throw such nonsense units at you, but keep track: sometimes you might need to convert units (e.g. convert all costs to dollars before adding). Ensure each term in a sum represents the same kind of quantity so that their expectations can sum directly.

- *Decision criterion nuance:* Using expected value as a decision criterion assumes you value outcomes proportional to their average (risk-neutral perspective). The FE exam won't delve deep into risk preferences, but be aware that choosing purely by expected value ignores variability. In real engineering economics, one might also consider worst-case or variance. However, if the question is framed around expected values, they expect you to compute and compare those straightforwardly.

Variations and Related Forms:

- **Breaking it down further:** Linearity extends to any number of terms. If you have an expected total involving many components, you can structure the problem in pieces. For example, if total energy $E_{\text{total}} = E_{\text{motor}} + E_{\text{heater}} - E_{\text{loss}}$, then $E[E_{\text{total}}] = E[E_{\text{motor}}] + E[E_{\text{heater}}] - E[E_{\text{loss}}]$. You might compute each expected energy from context (perhaps using other formulas or data) and then sum/subtract accordingly.

- **Expectation of an average:** If you take the average of several random variables, say $Z = \frac{1}{n}(X_1 + \cdots + X_n)$, linearity combined with scaling tells you $E[Z] = \frac{1}{n}(E[X_1] + \cdots + E[X_n])$. In particular, the expected value of a sample mean is the population mean – an important principle in statistics (unbiased estimator). This is a direct consequence of linearity.

- **Application – decision trees:** In decision analysis, you might use linearity implicitly when calculating expected values along branches of a decision tree. For instance, if one branch yields $1000 profit and another yields $500 loss, with certain probabilities, the expected value of that decision is the probability-weighted sum (which is a linear combination of those branch outcomes). The property ensures you can sum those weighted outcomes directly.

- **Relation to variance:** It's worth noting how different expectation is from variance in terms of linearity. While $E[X+Y] = E[X] + E[Y]$ always, the variance satisfies $Var(X+Y) = Var(X) + Var(Y) + 2\,Cov(X,Y)$ in general. Only if X and Y are independent (so $Cov = 0$) do variances add. This difference often appears as a conceptual question. So remember: **means add unconditionally; variances add only under independence (and it's the variances that add, not standard deviations).**

- **Alternate terms:** You might hear linearity of expectation referred to simply as **additivity of expected values**. It's a simple rule but extremely useful. Occasionally, textbooks phrase it as "the expected value of a sum is the sum of the expected values." That's exactly the same rule. Keep an eye out for language like "on average, the total = sum of averages" in word problems – that's an invitation to apply this property.

Special notes (calculator and exam strategy): There's usually minimal computation difficulty when using linearity – it's more about recognizing you *can* do it. If a problem gives you $E[X]$ and $E[Y]$ outright, you might just add or subtract them. If you need to compute each expectation first, do those individually (as shown in subtopic S01) and then combine.

Double-check signs and coefficients: a quick mental check can prevent arithmetic mistakes (e.g., if one part's expected value is negative, ensure it subtracts correctly). Also, use this property to save time: if a question asks "What is the expected total of ...?", go straight for adding means rather than, say, building a full probability table for the total. Often the exam writers give you just enough info to apply linearity without extra fuss.

Explanation & Analysis: The linearity of expectation is essentially an efficiency principle. It tells you that expectation "plays nice" with addition. From a practical standpoint, this means you can **analyze complicated systems component-wise**. For example, imagine a manufacturing scenario: The total cost X_{total} is the sum of material cost X_{mat} and labor cost X_{lab}. If material cost has an expected value of \$50 per unit and labor cost has an expected value of \$30 per unit, then without needing any further information, you know the expected total cost is \\$80 per unit. Even if material and labor costs fluctuate together or depend on each other in reality, their averages simply add. On the FE exam, a problem might state something like, *"Expected material cost = \$50, expected labor cost = \$30. What is the expected total cost?"* This is a direct application of linearity.

Let's break down a more involved example: suppose you're evaluating two design options for a project.

Option A has a 50% chance to yield \$100k profit and 50% chance to break even \$0 (perhaps depending on demand), so $E[\text{Profit}_A] = 0.5(100) + 0.5(0) = \$50k$.

Option B has two independent components: it will definitely give a baseline \$30k (guaranteed contract), plus it has a 50% chance of an additional \$60k bonus (and 50% chance of no bonus).

Here, break it into parts: a constant part $C = \$30k$ and a random part X that is \$60k with 50% probability or \$0 otherwise (with $E[X] = 0.5(60) + 0.5(0) = \$30k$). By linearity, $E[\text{Profit}_B] = E[C + X] = E[C] + E[X] = 30k + 30k = \$60k$. Option B's expected profit is \$60k, higher than A's \$50k, so on average B is the better choice. Notice how we didn't have to enumerate all scenarios of Option B jointly; we handled the guaranteed and variable parts separately and added their expectations. This illustrates how linearity streamlines decision calculations. It also shows that including the constant \$30k was important – if you mistakenly only considered the bonus (random) part's expectation, you'd have gotten \$30k and might wrongly compare that to A's \$50k.

Each term in a linear combination contributes additively to the total expectation. Analyzing term by term: in the above Option B, the guaranteed \$30k contributes exactly \$30k to the expectation (since it's always there), and the bonus contributes \$30k in expectation. The sum gives the total expected outcome. Physically, you can imagine averaging many repeated trials: Option A's outcomes alternate between 100 and 0, averaging to 50; Option B always gives 30, plus half the time another 60, averaging to 60. The power of linearity is that you could compute those averages piecewise.

Another analytical perspective: Because expectation is linear, **the order of operations doesn't matter** for sums and constants. You can sum first then take expectation, or take expectations first then sum – result is the same. Mathematically, $E[X_1 + X_2 + \cdots + X_n] = E[X_1] + \cdots + E[X_n]$. This is why you can confidently break problems apart. For instance, if you know $E[X]$ and $E[Y]$ separately, you automatically know $E[X + Y]$. And if a problem gives you a formula like $Z = 5X - 3Y$, you can plug in the means: $E[Z] = 5E[X] - 3E[Y]$. This linear plug-in approach is extremely reliable and quick.

In summary, **linearity of expectation** is a simple rule with big payoff in problem solving. It ensures that the expected value metric is easy to work with even for complex sums. On the FE Mechanical exam, use it to simplify expected value calculations for totals, differences, or weighted sums. It's one of those tools that makes many seemingly complicated probability questions turn into basic arithmetic. Just remember: it works for addition and scalar multiplication *every time* – leverage it whenever applicable, and you'll avoid a lot of unnecessary complication in expected value problems.

Topic 04 - Regression, Curve Fitting, and Goodness of Fit

Topic Intro: *Regression, curve fitting, and goodness of fit* deals with finding the best mathematical relationship (often a simple line) to describe how one set of data relates to another, and assessing how well that relationship explains the data. On the **FE Mechanical Exam**, you might face questions like: "Given a set of data points, what is the **best-fit line** relating two variables?" or "What do the **correlation coefficient (r)** and **R^2 value** tell you about the data's trend?" This topic is important because it allows you to make predictions (curve fitting) and judge the **accuracy** of linear models (goodness of fit). In exam terms, expect straightforward scenarios: computing a linear regression line from a few data points, interpreting regression output, or assessing whether two variables have a strong linear relationship. The goal is to confidently apply the least-squares method for line fitting, extend the idea to multiple variables, and use **r** and **R^2** to quantify fit quality.

K02.T04.S01 – Simple Linear Regression (Least Squares Fit)

Principle (Intro): Simple linear regression fits a **straight line** through a set of (x, y) data points by minimizing the total **squared error** between the line and the points. It assumes one independent variable X and one dependent variable Y, related by a model $y = a + b\,x$. Key points include:

- *Best-fit line:* The least-squares approach determines the single line $y = a + bx$that produces the smallest possible total of squared vertical differences (residuals) between the observed data points and the fitted line.
- *Slope and intercept:* b is the **slope** (how much Y changes per unit X), and a is the **intercept** (the predicted Y-value when $x = 0$). These are determined from the data – **slope** is based on how X and Y **covary**, and **intercept** adjusts the line vertically to center on the data.
- *Application:* Use simple linear regression when you suspect a **linear trend** between two variables. It provides a predictive equation and is the foundation of more complex regressions. On the exam, if you get a small table of data, you can apply these formulas (or your calculator's stats mode) to find a and b.
- *Least-squares criterion:* "Least squares" means that the line is chosen such that the **sum of squares of errors** $\sum(y_{\text{actual}} - y_{\text{predicted}})^2$ is as low as possible. This tends to give a fair balance, avoiding large errors on any single point at the expense of others.

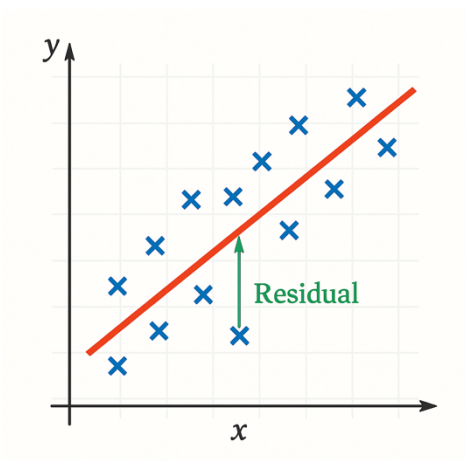

Figure: A scatter of data points (×) with the best-fit line obtained by least squares. The vertical arrow illustrates a residual e_i – the difference between an actual data value and the value predicted by the line for the same x. The least-squares method adjusts a and b so that the sum of all squared residuals is minimized. In exam problems, you may be asked to compute or identify this line; understanding that residuals should balance out (some above, some below the line) can help catch mistakes.

Exam Handbook Search Cues (Not affiliated with or endorsed by NCEES): *linear regression*, *least squares*, *regression line*, *intercept*, *slope*, *residual*

Footnotes: - *Units:* b (slope) has units of "Y per X" (e.g. if Y is in cm and X in s, b is in cm/s). The intercept a has units of Y (same units as the dependent variable). Always carry units through calculations to avoid confusion.

- *Notation:* The FE exam reference uses a for the line's intercept and b for its slope in simple regression. In other sources or in multiple regression, you might see b_0 for intercept and b_1 for slope, or symbols like α and β. They represent the same concepts (just be ready to recognize alternate notations).

- *Scope:* Simple linear regression is appropriate when data roughly follows a straight-line trend. If the relationship is strongly curved or otherwise non-linear, a straight line fit will be of limited use (though the exam typically sticks to linear fits unless specified otherwise).

- *Degenerate case:* If all your data points have the exact same X value (no variation in the independent variable), you **cannot** fit a meaningful line – the slope formula would involve division by zero (no change in X). The exam will avoid such cases or explicitly handle them (e.g. indicating that no correlation can be determined).

Variations & Related:

- *Alternate forms:* The formulas for a and b can be expressed in different but equivalent ways. A common form is in terms of data means and sums of squares: $b = \frac{\sum(x_i-\bar{x})(y_i-\bar{y})}{\sum(x_i-\bar{x})^2}$ and $a = \bar{y} - b\,\bar{x}$.

You might also see formulas using raw sums (Σx, Σy, Σx², Σxy); they yield the same results if applied correctly.

- *Special cases:* If the computed slope $b = 0$, the best-fit line is horizontal (Y does not change with X at all) – this indicates *no linear relationship* (Y is essentially constant w.r.t. X in the data). Conversely, a very steep |b| suggests a strong change in Y for a given change in X.

- *Extending the idea:* The least-squares principle isn't limited to lines. It can fit curves (parabolas, exponentials, etc.) by defining appropriate equations, and it generalizes to multiple linear regression (next subtopic). For the FE exam, however, focus on the straight-line case unless a different model is explicitly mentioned.

- *Typical values:* There's no fixed "expected" value for a or b; they

depend on your data scale. But it's good practice to sanity-check them. For example, if all measured Y's are around, say, 50 and only gently increasing with X, a slope $b = 100$ would be suspicious – it would predict changes far larger than observed. So ensure your computed line roughly follows the trend of the points (a quick plot or at least checking a couple of points against the equation helps).

Special Notes (Calculator Usage):

Most FE-approved calculators can greatly streamline linear regression calculations. For instance, **TI-36X Pro** and **Casio fx-991** models have a statistics mode where you can input (x, y) data pairs and get the regression line parameters directly (the calculator will output the slope b, intercept a, and often the correlation r). This can save time and reduce arithmetic errors on exam day. If you use this feature, double-check that you've entered all points correctly (one mis-typed pair can throw off the results – a quick look at the correlation or a recalculation can catch this). If you don't use the regression feature, plan to compute **Σx**, **Σy**, **Σx²**, **Σxy**, etc., using your calculator's summation capabilities or manually in a small table; then apply the formulas for a and b carefully. Remember that the exam handbook provides these formulas, so a common strategy is to write down the relevant sums and plug in systematically.

Equation Passport: *Least-Squares Regression Line* – computes the equation of a line that best fits a set of data points (x_i, y_i).

- **Professional Form:** $y = a + b\,x$, where

$$b = \frac{\sum_{i=1}^{n}(x_i - \bar{x})\,(y_i - \bar{y})}{\sum_{i=1}^{n}(x_i - \bar{x})^2},$$
$$a = \bar{y} - b\,\bar{x}.$$

Variables:

- n: number of data points (sample size).
- x_i, y_i: the individual data values (independent variable x, dependent variable y).
- $\bar{x}, \bar{y}$: the mean (average) of the x-values and y-values respectively.
- a: y-intercept of the best-fit line (value of Y when $x = 0$).
- b: slope of the best-fit line (rate of change in Y per unit change in X).

Assumptions:

– The relationship between X and Y is approximately linear in the range of interest.
– The data points are paired and independent; each y_i is related to its x_i (e.g. i-th measurement of X and corresponding measurement of Y).
– The **least-squares** method assumes we minimize vertical deviations; it's also assumed that the X values are known precisely and all randomness or error is in Y (this is a typical regression assumption – measurement error in X is beyond our scope here).
– No extreme outlier dominates the fit unduly (one very out-of-trend point can skew a and b; the method still "works," but the line may not be meaningful. The exam typically avoids tricky outlier scenarios unless it's the point of the question).

Limit tests (sanity checks):

– If the data have **zero correlation** (no trend), the formula will yield $b \approx 0$. Plugging that in gives $a \approx \bar{y}$. In other words, if X and Y aren't related, the best predictor of Y is just its average (a horizontal line).
– If the data points lie *exactly* on an increasing line, b will equal the true slope of that line and a the true intercept, with all residuals zero. If they lie on a perfectly decreasing line, b comes out negative (again exact fit).
– Check units: compute a quick slope in units by $\Delta Y / \Delta X$ using two far-apart points; it should roughly match your b. If your calculated b has a different sign or an off-by-10× magnitude, double-check your work.

- **Use vs. sibling equations:** Use this **least-squares line** instead of just connecting endpoints or doing a rough guess when you need a rigorous, quantitative fit. **Do not** confuse this with simply taking any two points to form a line – unless explicitly asked for something like a **Lagrange interpolation** or linear interpolation between two points, the regression line uses *all* the data collectively (via those summations). In summary, use the regression formulas when asked for the "best fit" or when more than two points are involved.

Common exam traps:

– **Mixing up X and Y:** The slope formula $\frac{\sum(x-\bar{x})(y-\bar{y})}{\sum(x-\bar{x})^2}$ implicitly assumes x is the independent variable. If you accidentally swap X and Y in the calculation, you'll get a different slope (essentially fitting Y vs X instead of X vs Y). Remember: we predict Y from X, not vice versa.

– **Forgetting mean adjustment:** A very common error is to compute $\sum x_i y_i$ and $\sum x_i^2$ and plug into a similar-looking formula $b = \frac{n\sum x_i y_i - \sum x_i \sum y_i}{n\sum x_i^2 - (\sum x_i)^2}$ (which is algebraically equivalent to the above) but forget one of the terms or misplace parentheses. It's easy to make arithmetic mistakes with sums – that's why using the calculator's stats mode or carefully breaking down the calculation is recommended.

– **Rounding too early:** The exam might have intermediate calculations that can be lengthy. If you round off mean values or sums too early, you could slightly throw off the final answer (e.g. slope or intercept). It's best to keep full precision in your calculator through the summations and division, then round the final answer appropriately. The FE typically allows a small range for numerical answers, but staying accurate is still wise.

– **Interpreting the intercept wrongly:** Remember that $a = \bar{y} - b\,\bar{x}$. If $\bar{x}$ is far outside your data range, the intercept might not have a meaningful physical interpretation (extrapolation). For example, if x represents load and y deflection, and all your data loads were between 10 and 50 N, the "predicted deflection at 0 N" (intercept) might be just a mathematical artifact. On an exam, if a question asks for the intercept's meaning, it's usually a straightforward interpretation ("the value of Y when X is zero") with the understanding of context.

Explanation: In practice, **simple linear regression** is used to model a linear trend between two variables. For instance, you might have data on engine efficiency (Y) at various ambient temperatures (X). By fitting a line $y = a + bx$, you get a quick predictive tool: plug in a temperature and get an estimated efficiency. On the FE exam, a typical problem could give you 3–5 data points and ask for the best-fit line's equation or a prediction at a certain X. Another common question is conceptual: given a scatter plot, which of several lines is the correct least-squares fit? (Answer: the one roughly balancing the scatter, not consistently over- or under-predicting in one region). Regression matters because it provides the **best unbiased linear estimate** of one variable given another. It

"matters on exam day" whenever you need to reduce a bunch of data to a simple formula.

Analysis: Let's break down how you *actually obtain* a and b, and what each part means. The core of the calculation is capturing how X and Y vary together versus individually. We compute S_{xx} = sum of squared deviations in X = $\sum(x_i - \bar{x})^2$, and S_{xy} = sum of cross deviations = $\sum(x_i - \bar{x})(y_i - \bar{y})$. The slope comes out as $b = S_{xy}/S_{xx}$. This formula makes sense: the numerator is positive and large if x and y tend to go up and down together (giving a positive b), or negative if x increasing leads to y decreasing (negative b). The denominator S_{xx} is just a measure of how much variation is in the independent variable; if x values don't vary much, we can't reliably infer a slope (hence more variation in X gives a more confident slope calculation). Once we have b, the intercept is determined by ensuring the line goes through the mean of the data: $a = \bar{y} - b\,\bar{x}$. This guarantees that the regression line passes through the point $(\bar{x}, \bar{y})$, an important property of least-squares lines.

Each symbol in the formulas has a meaning: a (intercept) is the starting value of Y when X = 0. For example, if you're fitting a line to predict *stress* from *strain* in a material test, and X is strain and Y is stress, the intercept a would be the predicted stress at zero strain (ideally near 0 if the material follows Hooke's law from the origin). The slope b in that context would be the stiffness (spring constant), telling you how many units stress goes up per unit of strain – which should correspond to Young's modulus in that simple case. On the exam, you should interpret b as **"per unit change"** effect: e.g., *"For each 1 °C increase in ambient temperature, the engine efficiency is predicted to increase by 0.2% (if* $b = 0.2$ *%/°C)."* The intercept would be *"At 0 °C, the model predicts an efficiency of ___,"* which you might then judge if it makes sense. Often, exam questions will be straightforward like "calculate a and b" or "what is the physical meaning of the slope in this context?"

When plugging numbers, be careful with the algebra: an exam problem might give you a small dataset, say (x: 1,2,3; y: 2,4,5) and expect you to compute the line. You'd do: $\bar{x} = 2,\ \bar{y} = 3.667$; then $S_{xx} = (1-2)^2 + (2-2)^2 + (3-2)^2 = 2$; and $S_{xy} = (1-2)(2-3.667) + (2-2)(4-3.667) + (3-2)(5-3.667) = (-1)(-1.667) + 0 + 1(1.333) = 3.000$. So $b = 3/2 = 1.5$. Then $a = 3.667 - 1.5 * 2 = 0.667$. Thus $y = 0.667 + 1.5x$. If you had any arithmetic slip (like sign errors in those deviations), you might get a different result – one quick check is to plug the mean values: at $x = \bar{x} = 2$, our line gives $y = 0.667 + 1.5 * 2 = 3.667 = \bar{y}$, which it should by construction. Also, check the line against each original point: for x=1, predicted y ~2.167 vs actual 2 (residual -0.167); x=2, pred 3.667 vs act 4 (residual +0.333); x=3, pred 5.167 vs act 5 (residual -0.167). The residuals aren't all zero, but they sum to zero and don't show a pattern (one positive, two negative small ones). That's how you know this is likely the correct fit.

Finally, be aware of **goodness of fit** even in simple regression: not every line is great just because we can compute one. That's where the **correlation coefficient (r)** and **R²** come in (see subtopic K02.T04.S03). For example, if your data points were very scattered, you'd get a shallow slope and a low R² – meaning the line doesn't explain much. In contrast, tightly clustered points along a line yield a steep or clear slope and high R². The FE exam might combine these ideas: after computing a regression line, you could be asked to comment on whether the correlation is strong or weak. So, in simple linear regression, always think: **slope** b tells you direction/steepness of the trend, **intercept** a anchors the line, and **r, R²** tell you how trustworthy that line is for prediction (addressed later).

K02.T04.S02 – Multiple Linear Regression (Model & Coefficients)

Principle (Intro): Multiple linear regression generalizes the linear fitting concept to **more than one independent variable**. Instead of fitting a line through points on a 2D graph, you're fitting a plane (or hyper-plane) through points in higher-dimensional space. The model is typically written as:

$$y = b_0 + b_1x_1 + b_2x_2 + \cdots + b_kx_k,$$

for k independent variables $x_1, x_2, \ldots, x_k$. Key points:

- *Linear model with multiple inputs:* Each term b_ix_i represents the contribution of the i-th variable to the prediction. The model remains **linear in the coefficients** b_i (each x is just multiplied by a coefficient and summed). This covers many situations: e.g., predicting a machine's output based on temperature, pressure, and humidity simultaneously.
- *Determining coefficients:* The coefficients $b_1, b_2, \ldots, b_k$ (and intercept b_0) are found by **least squares** as well – i.e. by minimizing the sum of squared prediction errors across all data points. This leads to a system of equations (often solved with matrix algebra or iterative methods). In practice, one uses statistical software or a calculator for this – manual calculation is tedious if $k > 1$.
- *Interpretation of coefficients:* Each coefficient b_i represents the influence of its associated variable x_i on y, assuming all other variables remain unchanged. For example, if $b_2 = -3.0$ in an equation $y = b_0 + b_1x_1 + b_2x_2$, it means "for each 1-unit increase in x_2, y is predicted to *decrease* by 3 units, assuming x_1 stays the same." This ceteris paribus interpretation is crucial in multiple regression.
- *Use cases:* Multiple regression is used when outcomes depend on several factors. It provides a more powerful predictive tool than single-variable regression, at the cost of more complex calculations. On the FE exam, you might not be asked to compute multiple regression coefficients from scratch (unless maybe for a very small dataset with 2 variables where you could solve by hand). More likely, you'll interpret a given multiple regression equation or recognize the form.
- *Model fit:* Just like simple regression has r and R², multiple regression uses **R²** to indicate overall fit (how much of the variability in y is explained by all the x's together). There is no single "r" for multiple unless referring to the correlation between actual and predicted y. As you include more variables, R² generally increases (the model can capture more variation), but each coefficient's relevance should be considered (some may turn out negligible if that factor doesn't actually influence y strongly).

Exam Handbook Search Cues (Not affiliated with or endorsed by NCEES): *multiple regression*, *multiple linear*, *least squares*, *normal equations*, *regression coefficients*

Footnotes:

- *Units:* Each coefficient b_i carries units of "Y per X_i." For instance, if y is a cost in dollars, and x_1 is length in meters, x_2 is mass in kg, then b_1 might be m and b_2 kg. The intercept b_0 has units of Y (the same units as the dependent variable) – it's the baseline value of Y when all $x_i = 0$. Always ensure that adding the terms b_ix_i results in consistent units summing to Y's units (this is a

good check for formula consistency).

- *Notation:* By convention, we use b_0 for the intercept (to distinguish it from the one-variable case where a was used) and $b_1, b_2, \dots, b_k$ for the slopes with each independent variable. In some contexts, you might see $y = \beta_0 + \beta_1 x_1 + \cdots + \beta_k x_k$ (especially in theoretical stats contexts). The meaning is the same, just different symbols. The exam will likely stick with b notation or simply give you a numeric example like $y = 5 + 2x_1 - 0.1x_2$.

- *Data requirements:* To solve for $k + 1$ coefficients (including b_0), you need more than $k + 1$ data points. With exactly $k + 1$ points, you could fit a model perfectly (zero error) but it may not be reliable. Generally, more data points improve the stability of the estimates. The FE exam won't ask about the statistical sufficiency of data, but be aware that with too few points relative to variables, the results can be nonsense.

- *Collinearity:* One important assumption is that the independent variables are not redundant. If one predictor is a linear combination of others (perfect collinearity), the regression problem becomes unsolvable (the normal equations become dependent). In less extreme cases, high correlation between predictors (multicollinearity) can make individual b_i estimates less reliable (though R^2 might still be high). The exam is unlikely to delve into this, but it's good to know why we assume the x's are "independent" of each other in a linear algebra sense.

- *Scope:* Like simple regression, multiple linear regression assumes linear relationships – the effect of each x_i on y is linear and additive. If the true relationship is nonlinear (e.g., $y = Ax_1^2$ or an exponential), you might need to transform variables or use a different model. Within the FE exam, unless they explicitly mention a nonlinear fit or provide a transformed form, assume linear models.

Variations & Related:

- *Polynomial regression:* This is a form of multiple regression in disguise. For example, fitting a quadratic $y = c_0 + c_1 x + c_2 x^2$ can be seen as multiple linear regression with two predictors $x_1 = x$ and $x_2 = x^2$. Each term $c_2 x^2$ is just another linear coefficient times a "variable" (here x^2 counts as the second variable). So the methods overlap – FE problems might simply say "quadratic curve fit" which conceptually uses the same least-squares principle.

- *Interactions:* Sometimes the effect of one variable depends on another (e.g., one factor amplifies the effect of another). In regression, an interaction term can be added (like $b_3 x_1 x_2$), but that term is **not linear in the original variables** (it's quadratic in terms of multi-dimensional space), so strictly that leaves the realm of "linear regression" (since now the model isn't linear in the coefficients if you consider each original variable separately). For FE exam purposes, you likely won't see interaction terms unless it's a very specific case.

- *Dimensional visualization:* For two predictors (k=2), the regression model $y = b_0 + b_1 x_1 + b_2 x_2$ can be visualized as a plane in 3D space (X1, X2 as horizontal axes, Y as vertical). Data points are scattered in that space, and the plane tries to pass as close to them as possible. The distance from a point to the plane vertically is the residual. For more than 2 predictors, visualization goes beyond 3D, but conceptually it's a hyperplane fitting multi-dimensional data.

- *Incremental R^2:* When adding variables, R^2 **never decreases** (it either stays the same or increases) because you have more flexibility to fit the data. However, adding too many variables can lead to overfitting (model fits noise, not just signal). There's an adjusted R^2 metric that penalizes adding variables that don't improve fit much, but that's beyond our scope. Just remember: if you see an R^2 from a multiple regression, know that it's accounting for all included variables.

Special Notes (Calculator Usage): Unlike simple regression, most exam-allowed calculators do **not** directly compute multivariable regressions. The TI-36X Pro, for example, can do linear regression for one independent variable, but not two at the same time. So, if a problem provided a small dataset with two predictors and asked for the best-fit plane, solving that by hand would involve writing out and solving normal equations (which is quite involved). The exam is more likely to either *provide the result* of a multiple regression (like output from a software or a given formula) and ask you to interpret it, or to restrict to simple regression calculations. If you ever needed to do a 2-variable regression by hand (for curiosity or worst-case), you'd set up equations: $\sum y = b_0 n + b_1 \sum x_1 + b_2 \sum x_2$, $\sum x_1 y = b_0 \sum x_1 + b_1 \sum x_1^2 + b_2 \sum x_1 x_2$, and $\sum x_2 y = b_0 \sum x_2 + b_1 \sum x_1 x_2 + b_2 \sum x_2^2$. Solving these simultaneously yields b_0, b_1, b_2. It's not necessary to memorize these normal equations (the exam handbook includes the general formulas if needed), but it's good to recognize them. Realistically, use the given data smartly: if they chose nice numbers, you might notice simplifications (sometimes one predictor might average out or be orthogonal). But again, **expect conceptual questions** more than brute-force calculation here.

Equation Passport:

Multiple Linear Regression Equation – computes a linear relationship between one outcome and multiple factors.

Professional Form: $y = b_0 + b_1 x_1 + b_2 x_2 + \cdots + b_k x_k$.

- **Variables:**
– y: dependent variable (the outcome you aim to explain/predict)
– $x_1, x_2, \dots, x_k$: independent variables (predictors or features).
– b_0: intercept term (the value of y when all $x_i = 0$; baseline).
– $b_1, b_2, \dots, b_k$: The slope coefficients correspond to each predictor x_i. Each $b_i$denotes the change in $y$resulting from a one-unit increase in x_i, while all other predictors are kept constant.
– (Implicitly n: number of observations in the dataset used to fit – needs to be > k to solve.)

- **Assumptions:**

– Linearity: The true relationship between y and each x_i is linear (within the range of data considered). The combined effect is additive (no complex interaction unless modeled as extra terms).

– Independence: Each observation's error (difference between actual and predicted y) is assumed independent of others; also, the predictors themselves ideally shouldn't have exact linear dependencies (see collinearity note).

– Least-squares optimal: The coefficients b_i are chosen to minimize the total squared error $\sum(y_{\text{actual}} - y_{\text{predicted}})^2$. This produces one possible solution for bs which is the best linear unbiased estimate if those assumptions hold.

– The data should not be extrapolated far beyond the region of the given x_i values – the linear model is only validated within the range of training data. (While this isn't a "mathematical" assumption, it's

a practical limitation: a plane fit might go haywire outside known points).

- Limit tests (sanity checks):

– If one of the predictors truly has no effect on y, the fitting process will yield a coefficient b_i near zero for that variable. On the exam, if you see a term like $+0.002x_3$ whereas other terms are, say, 5 or -3, that suggests x_3 is a weak factor.

– If two variables are very correlated (say x_1 and x_2 track each other closely), the model might assign some combined effect split between b_1 and b_2 in a less intuitive way. A quick check: if given the equation, see if making a small change in one variable while fixing others yields a reasonable change in y. For instance, with $y = 100 + 20x_1 - 19.5x_2$, if x_1 and x_2 measure related things (like one is in Fahrenheit, another in Celsius representing same physical temp), the coefficients might largely cancel out (which signals a collinearity issue). This is advanced, but just to say: trust the math but also interpret in context.

– Check dimensional homogeneity in each term: $b_i x_i$ should be in units of y. If not, something's wrong in set-up (this seldom comes up in exam since equations given will be consistent, but if you derive one, ensure consistency).

Use vs. sibling equations:

Use multiple regression when dealing with **multi-factor influence**. If you only have one significant independent variable, stick with simple linear regression (it's less complex and requires less data). If the relationship is clearly curved but one-variable (like a quadratic trend), either transform the data or use a polynomial regression (which is effectively multiple regression on powers of X). Do **not** try to force-fit a linear model if the problem explicitly calls for another model type (like "exponential fit", that's a different curve fitting technique). Recognize from context: if a problem mentions several input parameters affecting an outcome, it's hinting at a multiple regression or at least considering multiple factors.

Common exam traps:

– **Misinterpreting coefficients:** Every year some examinees see an equation like $y = 2 + 0.5x_1 - 1.2x_2$ and make a slip, e.g. "if x_2 increases by 1, then y decreases by 1.2, *regardless of* x_1." That statement is actually **correct** – the trap is if they forget the *regardless of* x_1 part. Make sure you phrase it as "holding the other variable constant." If a question asks, "What happens to y if x_2 increases by 1 and x_1 stays the same?" you apply the coefficient directly. But if both change, you have to account for both terms.

– **Plugging values in wrong places:** It sounds silly, but with multiple terms it's easy to mix up which coefficient goes with which variable if you're in a hurry. Keep track: write the equation clearly and label which number is b_1, b_2, etc. for each x. For instance, $y = 5 + 2x_1 - 0.1x_2$. If asked for y when $x_1 = 10, x_2 = 20$, do $5 + 2(10) - 0.1(20)$. Don't accidentally multiply 0.1 by x_1 or such. It helps to annotate: $= 5 + (2 * 10) + (-0.1 * 20) = 5 + 20 - 2 = 23$.

– **Ignoring intercept context:** In multiple regression, just like simple, the intercept b_0 is the starting value when all predictors are zero. Sometimes all predictors being zero is an unrealistic scenario (e.g., if $x_1 =$ temperature, $x_2 =$ pressure, zero for both might be outside any reasonable range). So the intercept might not be directly meaningful physically, but mathematically it's needed. An exam question might ask, "what is the interpretation of the intercept in this model?" If the context is such that $x_i = 0$ is meaningful (like 0 kg mass, 0°C temperature), you can state it. If not, it's fair to say it's an extrapolated baseline.

– **Overcomplicating**: Some examinees might think they need to memorize matrix formulas or perform Gaussian elimination for regression – you do not. If a direct computation is needed, the exam will keep it simple (maybe two equations, two unknowns). Often, though, you'll just reason about the sign or relative size of coefficients rather than calculate them.

Explanation: In words, a multiple linear regression provides a formula to calculate y from several inputs. For example, suppose you're dealing with the efficiency of an HVAC system, which depends on both outside temperature and humidity. A multiple regression might yield something like:

$$\text{Efficiency (\%)} = 75 + 0.1(\text{Temp in °C}) - 0.05(\text{Humidity in \%}).$$

Interpreting this: *75* is the base efficiency at 0°C and 0% humidity (a theoretical point), *0.1* means each 1°C increase in temperature raises efficiency by 0.1 percentage points (all else equal), and *-0.05* means each 1% increase in humidity lowers efficiency by 0.05 points (at constant temperature). So on a hot dry day vs. a cooler humid day, these terms trade off.

Why it matters on the FE Exam: you could be given such an equation and asked something like "what efficiency does the model predict at 30°C and 50% humidity?" or conceptually "according to the model, what is the effect of humidity on efficiency?" These are direct plug-and-play or interpretation questions. The exam expects you to understand that *each coefficient acts independently* in a linear model: you isolate one variable's effect at a time.

Another scenario: The question might present *partial output* of a regression (like "Regression equation: $y = 1.2 + 0.5x_1 + b_2x_2$. Given that when x_2 increases by 1, y drops by 3 (with x_1 fixed), what is b_2?"). This is essentially testing that you know $b_2 = \Delta y/\Delta x_2 = -3$ in that context. Or, you might get a small dataset with two predictors and be asked which of the two factors has a stronger influence on y (you would infer it from the magnitudes of coefficients if given, or maybe by computing sample slopes holding one constant).

Analysis: While you won't likely solve a full multi-regression by hand, let's peek at the mechanics to solidify understanding. The fitting process extends the normal equations concept mentioned: you'd set up one equation for each coefficient equating the derivative of error sum to zero. For two variables x_1, x_2, the normal equations we listed in the special notes are the result. Solving them yields formulas:

$$b_1 = \frac{\sum(x_{1i} - \bar{x_1})(y_i - \bar{y}) - b_2\sum(x_{1i} - \bar{x_1})(x_{2i} - \bar{x_2})}{\sum(x_{1i} - \bar{x_1})^2},$$

and similarly for b_2. It's not necessary to memorize, but notice if x_1 and x_2 are uncorrelated in your data (the cross-sum term is zero), these formulas decouple and each acts like its own simple regression on y. Usually, though, there is some correlation, so the coefficients influence each other's calculations.

Each term $b_i x_i$ is like a partial linear effect. If one coefficient is very large in magnitude relative to others (after accounting for variable units), that variable has a big impact on y. If one is near zero, that variable might not be contributing much linearly.

Common pitfalls to analyze: one is extrapolation: if you have an equation and plug in values far beyond the data range, the prediction could be physically unreasonable (e.g. negative efficiency or such). The FE exam may ask a trick question like "Using the model $y = 75 + 0.1T - 0.05H$, what happens at T=100°C, H=100%?" If the context is, say, a typical environment, 100°C might be outside feasible range – any answer from the model is just a math result, not physically valid. So the safe move is to note the intended domain of the model.

Another analysis angle: Check consistency with intuition. If all b_i were positive, it means increasing any predictor increases y. If one of them intuitively should reduce y (like friction coefficient might reduce efficiency), but your model gave a positive coefficient, it could be because the effect is being masked or misattributed due to correlation with another variable. In exam context, they likely ensure the sign makes sense logically to avoid confusion, but it's something to be mindful of.

As for calculation: if you *did* attempt a small example by hand, say you have data (perhaps 3 points) for y with two x's, you could solve the 3 equations for b_0, b_1, b_2. It's a linear algebra exercise. But practically, multiple regression on the FE is about understanding and using the given model. So focus on interpretation: know that b_0 is baseline, each b_i is partial effect, and the model's predictions are obtained by plugging in values. Always double-check that you pair the right values: it helps to write a clear list of what each x_i is (with units if any) before computing y. That reduces mistakes. In summary, multiple linear regression expands your toolkit to handle more variables, and the exam will test that you can navigate its equation and meaning just as confidently as the simple one.

K02.T04.S03 – Linear Correlation Coefficient (r) and Coefficient of Determination (R^2)

Principle (Intro): The linear correlation coefficient, usually represented by r, quantifies both the strength and direction of a linear association between two variables, X and Y. The coefficient of determination, R^2, is closely related and indicates the proportion of Y's variance accounted for by its linear relationship with X; in simple linear regression, $R^2 = r^2$. These metrics fall under "goodness of fit," telling us how well a line (or linear model) actually fits the observed data. Key points:

- *Correlation coefficient (r):* Ranges from **-1** to **+1**. An **r = +1.0** means a perfect positive linear correlation (all points lie exactly on some upward-sloping line – Y increases as X increases). **r = -1.0** means a perfect negative linear correlation (all points on a downward-sloping line – Y decreases as X increases). **r = 0** means *no linear correlation* – knowing X doesn't give you any information about Y in a linear sense (the points would be a cloud with no apparent trend). Values in between indicate partial correlation: e.g. r = 0.8 is a strong positive correlation (points cluster around an upward line, but with some scatter), r = -0.5 is a moderate negative correlation, etc.
- *Coefficient of determination (R^2):* R^2 is essentially the **square of the correlation coefficient** when there's one predictor. It ranges from 0 to 1 (or 0% to 100% if expressed as a percentage). R^2 represents the **fraction of Y's variability that is explained by the linear model** with X. For instance, if $R^2 = 0.85$, we say "85% of the variation in Y can be explained by the linear relationship with X." The remaining 15% is due to other factors or inherent variability. A higher R^2 means a better fit. If R^2 = 1, the line accounts for all variability (perfect fit); if R^2 = 0, the line explains nothing (the best-fit line is basically flat at $\bar{y}$).
- *Goodness of fit use:* On the exam, r and R^2 are used to judge how "good" a fit is. If you compute a regression line, you should also consider r or R^2 to interpret whether the line is reliable. Often, the FE exam will give you r or R^2 in a problem statement or expect you to compute it from data. For instance, a question might ask, "The correlation coefficient between engine size and fuel consumption is 0.9. What can you say about the relationship?" (Answer: very strong positive linear relationship – larger engines tend to consume more fuel, linearly). Or you might be given a small dataset and after computing the line, asked to find r to gauge the fit.
- *Symmetry and units:* Note that r is **unitless** (because it's a ratio of covariances to variances) and symmetric: correlation of X with Y is the same as Y with X. It doesn't matter which variable you call independent when computing r – it's just measuring association. R^2 is also unitless, being just a ratio of variances. Because of this, you can compare correlation strengths across different datasets or contexts.
- *Limitations:* Both r and R^2 **only measure linear association**. An r near 0 doesn't necessarily mean "no relationship at all" – it might just mean no *linear* relationship. For example, if Y = X^2 (a perfect parabola through origin), the correlation r might be close to 0 if X is symmetrically distributed about 0 – yet there's a perfect quadratic relationship. The exam might implicitly test this concept by showing a scatter plot that's obviously curved: the correlation would be low, but one shouldn't conclude independence, just lack of linear correlation. Typically, though, FE problems keep it straightforward: linear trends.

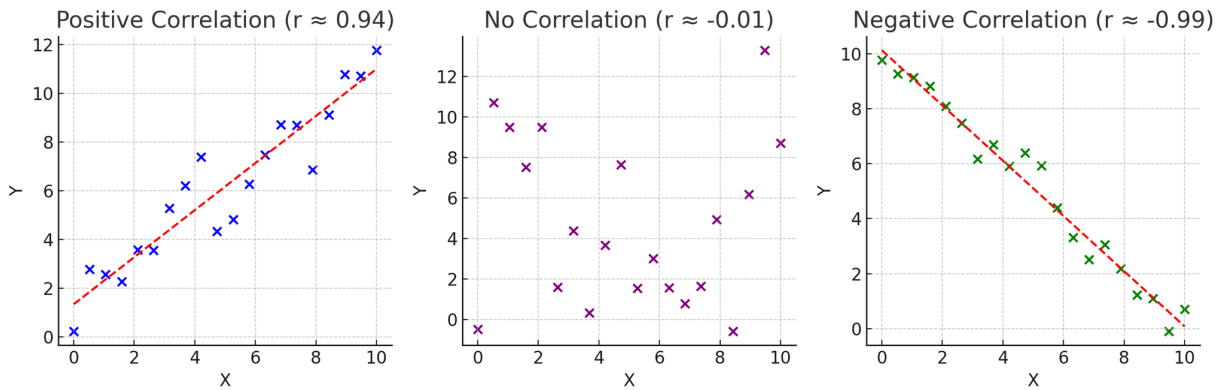

Figure: Examples of correlation strength and direction. Left: A strong positive correlation ($r \approx 0.94$): as X increases, Y increases in a fairly linear fashion (points cluster about an upward sloping line, shown dashed). Middle: Essentially no correlation ($r \approx -0.01$): the points appear random with no discernible linear trend; knowing X doesn't predict Y. Right: A strong negative correlation ($r \approx -0.99$): as X increases, Y decreases almost perfectly along a downward line. In each plot, a best-fit line is drawn to illustrate the trend when one exists. Higher |r| means points hug the line closely; lower |r| means they are widely scattered.

Exam Handbook Search Cues (Not affiliated with or endorsed by NCEES): *correlation coefficient*, *R²*, *coefficient of determination*, *goodness of fit*, *Pearson r*

Footnotes: - *Unitless measure:* Both **r** and **R²** are pure numbers without units. This is helpful because you can interpret them universally (an $r = 0.8$ is "strong" whether you're correlating meters with seconds or gallons with dollars – unit conversion won't change r). If you ever calculate r and get something outside the range [-1, 1], that indicates an arithmetic mistake – r **must** lie in [-1,1].

- *Sign of r:* The sign (+ or -) of r is crucial. It tells you **direction** of the linear relationship. A positive r indicates that the two variables rise together, while a negative r shows that as one variable increases, the other decreases. In contrast, R^2 is always zero or positive and only reflects the strength of the linear fit, without indicating direction. On exam day, if you're given R² and asked about correlation, consider the context or the sign of the slope from the regression to determine the sign of r. *Example:* If a regression line has a negative slope and you know $R^2 = 0.81$, then $r = -0.9$ (the correlation carries the minus sign).

- *Multiple regression context:* With multiple independent variables, there isn't one single r between "X and Y" because X is multivariate. In that case, R² is still defined: it's the fraction of variance in Y explained by the *entire set* of X variables. Sometimes people refer to a "multiple correlation coefficient" R (capital R) which is the correlation between the *predicted* Y from the model and the actual Y. In simple regression, that R is the absolute value of our r. In multiple regression, R^2 is more commonly cited than R itself. The FE exam might give an R² for a multiple regression output to indicate fit quality. Just remember, you can't directly get a notion of "positive or negative" correlation in multi-variable case from R² alone – you'd look at individual coefficients for that.

- *Interpretation pitfalls:* A high correlation or R² does **not imply causation**. The exam may include a conceptual question like "Data shows a high correlation between ice cream sales and road pavement softening. Does one cause the other?" The answer is likely "No – a lurking variable (temperature) causes both; correlation ≠ causation." So be cautious: r quantifies association, but context matters for causality. Also, if you see a high r but suspect it's coincidental (small sample, or data cherry-picked), in reality one would do further significance testing – but in the FE context, they might simply expect you to identify that "the correlation is high/low" and maybe be aware of outliers.

- *Effect of outliers:* An outlier (an oddball data point) can dramatically affect r in a small dataset. If one point lies far off the trend, it can drag the correlation down (or up) disproportionately. If you have time, scanning the data for obviously inconsistent points is useful. The exam might not delve deeply into this, but a savvy test-taker knows to be careful: one weird data point can make an otherwise strong correlation look weak (or vice versa).

- *Standard error vs R²:* Another goodness-of-fit measure in regression output is the **standard error of estimate** (essentially the standard deviation of residuals). While R² tells you the relative explanatory power, the standard error gives the absolute size of a typical error. The FE exam focuses on r and R² primarily, but just note: a tight fit means both a high R² and a low residual standard error.

Variations & Related:

- *Pearson vs others:* The linear correlation coefficient we discuss is Pearson's r. There are other types (Spearman's rank correlation for non-linear monotonic trends, etc.), but those are beyond FE scope. If a problem says "correlation," assume Pearson correlation (linear).

- *R² for nonlinear fits:* If you fit a nonlinear model (say an exponential), sometimes people still report an "R²" for how well that model fits. The interpretation is similar (variance explained), but calculation is different. Again, FE will not require computing that – but they might give an R² for any model just to tell you it fits well or not.

- *R, R² naming:* As a footnote, you might see in some references or software output: "R" (multiple R) and "R²". In simple regression, "multiple R" is just |r|. In multiple regression, "multiple R" is the correlation between actual and predicted Y. In the FE Reference Handbook there's a section on the sample correlation coefficient R and the coefficient of determination R^2. They use capital R for the sample correlation, but the concept is the same as the lowercase r

used in many textbooks. Don't let notation confuse you: whether they use R or r, it's the same concept here, and R^2 is always the squared value (we usually use capital for the multiple regression case, but NCEES material might use capital R generically).

- *Typical values (rule of thumb):* There's no hard cutoff, but often in engineering, |r| above ~0.8 is considered strong correlation, 0.5–0.8 moderate, and below 0.5 weak – this is just an intuitive guide. R^2 above 0.8 means the model is capturing 80%+ of the variance (very good), around 0.5 means half the variance (okay, moderate fit), and low R^2 means the linear model leaves a lot unexplained. On exam, if you see an $R^2 \sim 0.2$, you'd likely conclude the linear fit is poor (there's a lot of scatter). Conversely, R^2 of 0.95 means an excellent fit (points lie almost perfectly on the line).

- *Sum of squares breakdown:* In regression analysis, one way to get R^2 is $R^2 = 1 - \frac{\text{SSE}}{\text{SST}}$, where SST is total sum of squares ($\sum(y_i - \bar{y})^2$, total variance of Y) and SSE is sum of squared errors ($\sum\left(y_i - y_{\text{predicted}}\right)^2$, the variance not explained by the model). The difference (SST - SSE) is often called SSR (sum of squares due to regression, i.e., explained variance). Then $R^2 = \frac{\text{SSR}}{\text{SST}}$. You might see that in some contexts. The FE Reference Handbook includes definitions like these in the statistics section. While you probably won't need to perform those calculations by hand, understanding that *R^2 is literally the ratio of explained variation to total variation* can deepen your insight. For instance, if SST = 200 (total variance) and SSR = 150 (explained by model), then SSE = 50 (unexplained) and R^2 = 150/200 = 0.75 or 75%.

- *Adjacent topics:* Goodness-of-fit assessment using r and R^2 often goes hand-in-hand with **hypothesis testing** of correlation or regression coefficients (e.g., t-tests on slope, ANOVA F-test on overall regression). Those are topics on the exam as well (typically under hypothesis testing). While we won't dive deep here, just be aware: a high R^2 suggests significance, but formally one might test if r is significantly different from zero given sample size. The FE might include a conceptual question like "if r is 0.9 with n=5 points, is that necessarily significant?" (the answer: with very few points, even high r might occur by chance, but usually they won't ask this without giving a way to decide).

Special Notes (Calculator Usage): If you use your calculator's regression feature (as noted earlier), most will provide **r** (or at least R^2) as part of the output for linear regression. For example, after entering data, the TI-36X Pro can show you the value of r and R^2 (you might have to scroll to see it). This is extremely useful: you can quickly verify, for instance, that r is close to 1 or 0, giving you immediate feedback on the data trend. On exam day, if a question asks for the correlation or R^2, using the calculator after inputting the data pairs is the fastest way. Just be mindful: some calculators default to showing **r** for linear regression and some show **r^2**; know which one you're looking at. If your calculator only gives R^2, you can always take the square root (and infer the sign from the slope as discussed). If you're not using the regression feature, you can compute r by the formula:

$$r = \frac{\sum(x_i - \bar{x})(y_i - \bar{y})}{\sqrt{\sum(x_i - \bar{x})^2 \sum(y_i - \bar{y})^2}}$$

It's a lot to compute by hand for more than a few points, but for a small dataset (maybe 3–4 pairs) it's manageable if needed. Ensure you calculate those sums accurately, and again, avoid rounding until the final division for best accuracy. One trick: if you already computed the slope b and you have the standard deviations of X and Y (or can get them), $r = b \times \frac{s_x}{s_y}$ in simple regression (since $b = r(s_y/s_x)$). But that requires knowing standard deviations. In any case, the exam might give intermediate values to help. Also remember: correlation is unaffected by changing units or shifting the origin of either variable (since it uses standardized deviations). So if you ever feel the numbers are awkward, sometimes converting units (all X in say cm instead of m, or centering values by subtracting mean) won't change r, it might simplify calculation – though do this only if confident.

Equation Passport:

Correlation Coefficient and Coefficient of Determination – quantifies linear relationship strength and fit quality.

- **Professional Form (Correlation r):** $r = \frac{\sum_{i=1}^{n}(x_i - \bar{x})(y_i - \bar{y})}{\sqrt{\left[\sum_{i=1}^{n}(x_i - \bar{x})^2\right]\left[\sum_{i=1}^{n}(y_i - \bar{y})^2\right]}}$

Coefficient of Determination: $R^2 = r^2$ (for simple linear regression).

Variables:
– x_i, y_i: data pairs as before.
– $\bar{x}, \bar{y}$: means of X and Y.
– n: number of data points.
– r: Pearson correlation coefficient (sample correlation) between X and Y.
– R^2: proportion of variance in Y explained by X via a linear model.

Assumptions:
– Data is measured on an interval or ratio scale (so that mean and variance make sense).
– Relationship (if any) is roughly linear; no wild outliers that completely distort the picture (or if there are, one might analyze with and without them).
– Each (x,y) pair is independent of others. For example, you wouldn't want to correlate "year of study" with "knowledge" by polling the same student each year (those points are not independent). This is a subtlety; typical FE problems use independent observations.
– For interpreting R^2 in regression: the linear model is the correct form for relating X and Y (or at least a decent approximation). If not, R^2 might be low even if there's a strong non-linear link.

Limit tests:

– If $r = 0$, then $R^2 = 0$. Your best-fit line in that case is horizontal at $y = \bar{y}$. It doesn't mean X and Y have no relationship whatsoever, but any relationship isn't captured by a straight line. Be careful: $r = 0$ might hide a curved pattern. On an exam, if they show a scatterplot that looks like a U-shape, the correlation could be near 0 even though there's a clear pattern.

– If $r = \pm 1$, then $R^2 = 1.0$. That means every point lies exactly on some line (all residuals zero). In such cases, b from regression would match $\Delta y/\Delta x$ between any two points; basically you don't even need a formula because two points determine the line exactly (and all points follow it). If you ever calculate r and get exactly 1 or -1 (and it's not a rounding artifact), it implies a perfect linear alignment of data.

– If R^2 is high (close to 1), then SSE is small relative to SST. That means the regression line's predictions y_{pred} are very close to actual y_i's most of the time. A quick check: look at the scatter vs line – do points hug the line? If yes, expect high R^2. If no, R^2 will be low.

– Because r involves products $(x - \bar{x})(y - \bar{y})$, if you flip one variable's scale (say replace Y by -Y), r's sign will flip but R^2 stays same. If you shift either variable by a constant (like use Celsius vs Kelvin for temp), r and R^2 don't change at all (since the deviations from mean remain same shape). If you scale variables (feet vs meters), again r stays the same (scaling cancels out in that ratio). Thus, correlation is invariant under linear transformations of either variable (except for sign flips if a negative scale factor). This is a good sanity check: your correlation calculation shouldn't depend on units.

Use vs. sibling measures:

Use **r** and **R^2** when you need to report or utilize the strength of a linear fit. If you are dealing with relationships but not necessarily linear, other measures might be appropriate (outside our scope). Also, use R^2 rather than r if you're talking about how much variance is explained. For example, an exam question might say "The data's R^2 with respect to a linear fit is 0.6" – you'd know 60% of variation is explained. Use r when discussing correlation specifically or when determining the sign of relationship. Don't confuse **correlation** with **regression slope**: correlation being zero doesn't mean slope is zero if measured in weird ways? Actually in simple linear regression, yes it does – zero correlation means zero slope. But correlation is more general concept for association strength. On the exam, if they give you r, you can square it to get R^2 for fit quality; if they give R^2 and you need r, you'd take square root and assign the proper sign.

Common exam traps:

– **Forgetting to take square root or square:** If a problem gives you $R^2 = 0.49$ and asks for correlation, don't answer 0.49! The correlation magnitude is $\sqrt{0.49} = 0.70$. Then determine the sign from context. Conversely, if r = 0.7, $R^2 = 0.49$. It's easy to mix them up under pressure, so double-check what the question is asking for.

– **Misinterpreting percentage:** An R^2 of 0.5 means 50% of variance explained, which is significant but leaves 50% unaccounted for. Some might say "the linear model is only 50% accurate" – that phrasing is off. It's not about being "50% accurate" on each prediction; it's about variance explained. So a better interpretation: "half of the variability in Y is explained by X linearly." On an exam, a likely question is: "If $R^2 = 0.8$, what does that imply about the data/model?" The safe answer: "80% of the variation in Y is explained by the linear relationship with X (i.e., by the regression)."

– **Using correlation instead of causation:** As mentioned, high correlation could be coincidental or due to a third factor. An exam question in ethics or engineering reasoning could test this: e.g., "There is a high correlation between two safety metrics; should we conclude one improves the other?" The answer would caution not necessarily – they both might improve due to a separate cause. So don't over-interpret r as a proof of cause-effect.

– **Rounding and sign:** If calculating r by hand, small rounding errors can shift the third decimal place and possibly make a difference in a multiple-choice scenario. It's best to keep more significant figures during calc. And when reporting, include the sign. For instance, writing "r = 0.95" without a sign when describing a downward trending dataset would be incomplete/wrong – it should be r = -0.95 if Y decreases as X increases.

– **Confusing r with other uses:** In some formulas, r might denote something else (like radius in a circle, or the symbol ρ (rho) for population correlation). Context is key. In our Probability & Statistics context, r is correlation. Just be sure to not mix it up with, say, the *Spearman rank correlation* (which is sometimes also denoted by ρ) – FE won't go there likely.

Explanation: The correlation coefficient **r** tells you at a glance how well two variables go together. If you plotted your data and drew a regression line, r indicates how tight the points are around that line and whether the line slopes up or down. For example, imagine you measured the torque and current for a motor across various loads, and got r = 0.95. That means torque and current have a very strong positive linear relationship – likely the points line up nicely, and a linear model will predict one from the other with high confidence. If another experiment gave r = -0.2 between two quantities (say, ambient humidity and tensile strength of some material, making that up), that's a very weak negative linear relationship – practically, you'd say there's no clear linear trend; any slight negative tendency might be drowned in noise. On exam day, you might be given r or R^2 as part of a scenario and need to interpret it in plain English ("strong linear relationship," "weak correlation," etc.). Or you might have to compute them from a small dataset. It's also possible the exam asks conceptually: *"Which measure would you use to judge how well a line fits the data?"* The answer is R^2 (coefficient of determination) since it quantifies goodness of fit. *"Which measure tells you the direction of a linear association?"* That's the correlation coefficient r (sign indicates direction).

Furthermore, consider how r and R^2 play into **goodness of fit**: A high R^2 implies your regression equation is doing a good job. For instance, if you fit a line to data and get $R^2 = 0.98$, you can be confident in using that line for interpolation. If $R^2 = 0.25$, any predictions from the line will be very rough – the data is quite scattered. In quality control or experimental science, it's common to require R^2 above a certain threshold to consider a calibration valid. The FE exam might not ask for specific thresholds, but qualitatively, know that 0.9 is excellent, 0.5 mediocre, etc.

Analysis:

Breaking down the **formula for r**, it's essentially:

$$r = \frac{\text{(covariance of X and Y)}}{\text{(std. dev. of X) (std. dev. of Y)}}.$$

The numerator $\sum(x_i - \bar{x})(y_i - \bar{y})$ is the *covariance* (up to the factor $1/n$ which doesn't affect the sign or zero point). Covariance measures how X and Y vary together: if x_i above mean tends to coincide with y_i above mean, this sum is positive (giving r > 0). If one is above its mean while the other is below, those terms are negative (r < 0 if that consistently happens). The denominator just normalizes by the spreads of X and Y. That's why r is unitless and capped at 1: we divide by the product of spreads, so we're basically measuring how large the co-variations are relative to total variability. If X and Y are perfectly aligned, every deviation in X has a proportional deviation in Y, so that ratio hits the maximum of 1. If X and Y have nothing to do with each other, sometimes X is high while Y is high, sometimes X is high while Y is low, etc., and the positive and negative contributions cancel out, giving a numerator near 0 and thus r near 0.

One important relationship in simple linear regression: the slope b and correlation r are connected by $b = r\frac{s_y}{s_x}$, where s_x and s_y are the sample standard deviations of X and Y. This makes sense dimensionally: b has units of Y/X, while r has no units; multiplying r by s_y/s_x gives something with units of Y/X, which is the slope. So if you know r and the data spreads, you could find the slope quickly. Conversely, the sign of b is the sign of r. This is why earlier we emphasized that sign of correlation = sign of slope in a two-variable linear regression.

Now, **coefficient of determination (R^2)** provides an intuitive interpretation: it's the fraction of variance in Y "captured" by using X. If you didn't have X at all, your best guess for any Y would be $\bar{y}$, and the variance in your error would just be the variance of Y itself. When you use X with a regression, your errors are the residuals (actual minus predicted). R^2 basically asks: how much smaller is that error variance compared to just guessing the mean every time? For example, $R^2 = 0.75$ means your prediction errors' variance is only 25% of the original variance; you cut uncertainty by 75% thanks to the linear model with X. If $R^2 = 0$, your prediction isn't better than just using the mean of Y (the line is flat at $\bar{y}$). If $R^2 = 1$, your prediction has zero error variance (no uncertainty left; points fall on the line).

When computing these by hand in an exam context: for a small dataset, you can actually compute r fairly directly. Suppose you have 3 pairs of points, you could plug into the formula systematically. It can be time-consuming, so often exam problems might give you intermediate values like sums or means to plug in. Use those if provided. Another trick: if you already found the slope b and you know the standard deviations, you can get r quickly as mentioned. Or, if you have to judge without calculating, use logical reasoning: are the points nearly on a line? Then r is high. Are they very scattered? r is low. They might even give you a visual scatter plot and ask which of several r values is most plausible. In such a question, note the trend direction (positive slope or negative) to get the sign right, and eyeball how tight the cluster is.

Finally, tie this back to **goodness of fit** in multiple regression: When more variables are involved, we rely on R^2 since r as a single number doesn't apply. But conceptually, R^2 still means "how much of Y's variance did our model explain?". If you ever see "adjusted R^2" in a reference, that's a minor detail adjusting for number of predictors (to avoid overestimation when k is large relative to n). The unadjusted R^2 can be artificially high if you keep adding variables, even random ones. But the FE exam likely won't require computing adjusted R^2, just understand basic R^2.

In summary, r and R^2 are your go-to measures to **validate a regression model**. After finding a regression line in a problem, if part (b) asks "Comment on the goodness of fit," you'd respond with the R^2 value (or r) and a qualitative statement like "This R^2 of 0.95 indicates an excellent fit; the linear model is highly reliable for this data." Or "R^2 of 0.20 indicates a weak fit – the linear model doesn't explain much of the variation, so predictions will be uncertain." Being able to make that call is part of demonstrating understanding of regression on the FE. It's not just crunching numbers, but also interpreting what they mean for the data's story.

K02.T04.S04 – Basics of Curve Fitting and Model Adequacy

Principle Introduction: Regression analysis is about finding the **best-fit curve** (often a straight line) through a scatter of data and evaluating **model adequacy** (how well that curve represents the data). Key points include:

- Engineers frequently **fit a straight line** or simple curve to experimental data to create a formula for prediction or design. For example, you might fit a line to relate temperature and pressure from lab measurements, enabling easy interpolation between measured points.
- The most common method is **Least Squares Linear Regression**, which finds the line $y = a + b\,x$ that **minimizes the sum of squared residuals** (the differences between the actual measurements and the line's predicted values). This ensures an optimal trendline where positive and negative errors balance out and large errors are penalized heavily (squares).
- **Residual analysis** is the practice of examining those differences (residuals) between data and the model. If the residuals are small and randomly scattered (no clear pattern when plotted), the model is considered **adequate** for the data. A pattern (e.g. residuals getting systematically larger or changing sign in one direction) signals the model might be missing something (perhaps the true relationship is curved, or an outlier is skewing the fit).
- **Goodness of fit** measures quantify how well the model explains the data. The **correlation coefficient** (typically denoted *R* or *r*) indicates the **strength and direction** of a linear relationship. Its square, **R^2** (the **coefficient of determination**), indicates what fraction of the variance in the data is captured by the model. An R^2 close to 1 (or 100%) means an excellent fit; near 0 means a very poor fit. These metrics, along with visual residual checks, tell you if your trendline is trustworthy for predictions.

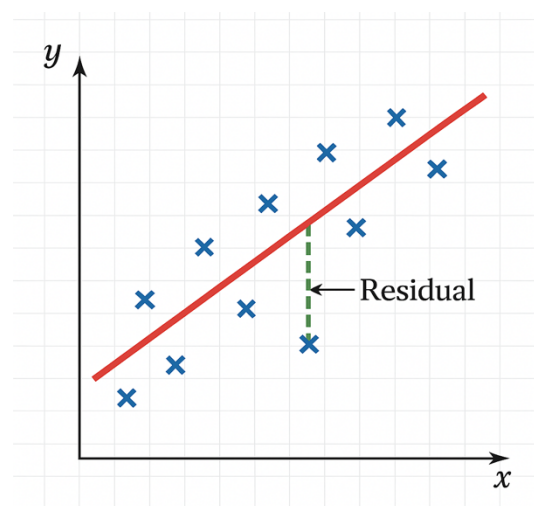

Figure: Example of a linear regression fit through a set of data points. The crosses are measured data, and the diagonal line is the least-squares best-fit line $y = a + b\,x$. The dashed vertical segment illustrates the residual for one sample point (the vertical difference between the actual data point and the line's predicted value for that same x). In a good fit, residuals are generally small and scatter randomly around zero. If residuals show a clear pattern or systematic trend (for instance, steadily increasing or following a curve), it suggests the linear model may be inadequate for the data (perhaps a curve or higher-order fit is needed, or an outlier is influencing the results).

Exam Handbook Search Cues (Not affiliated with or endorsed by NCEES): *linear regression; least squares; residual; correlation coefficient; coefficient of determination; goodness of fit*

Footnotes:

- *Units:* Be mindful of units when performing regression. The slope **b** will have units of "y per x". For example, if you fit a line to relate force (N) vs. length (mm), **b**'s units will be N/mm. Always convert to consistent units **before** fitting; mixing units (like some lengths in inches, some in mm) will yield nonsense.

- *Symbols:* The exam handbook uses **a** for the y-intercept and **b** for the slope of the line. The **sample correlation coefficient** might be denoted as **R** (or *r* in some texts – both represent Pearson's *r*). **R^2** (R-squared) is simply the square of that correlation coefficient. Don't confuse these symbols: **R** can be negative or positive (indicating the slope's direction), but **R^2 is always between 0 and 1**.

- *Scope:* "Regression" on the FE exam typically implies **simple linear regression** (one independent variable, one dependent variable, straight-line fit). The principles extend to multiple linear regression (several x variables) and nonlinear regression (fitting curves), but those are generally beyond the exam's requirements. Stick to identifying or computing the best-fit **straight line** unless the problem explicitly asks for another model.

- *Assumptions:* Least-squares linear regression assumes the relationship is roughly linear over the data range and that errors are random. In practice, it also assumes errors are normally distributed and homoscedastic (equal variance for all x) – deep statistical concepts rarely tested directly on the FE, but good to recall. In simpler terms, **check that nothing obvious violates a straight-line assumption**: no obvious curves in the data trend and no subsets of data that behave differently. One **observation**: the least-squares line always goes through the point $(\bar{x}, \bar{y})$ (the mean of x and mean of y) – a useful check if you ever derive the line manually.

Variations, Related Forms, Typical Values:

- *Multiple Linear Regression:* If you have more than one independent variable (say, fitting y as a function of $x_1, x_2, ...$), the least squares method extends to fit a plane or hyper-surface. For example, a multiple regression might yield $y = a + b_1x_1 + b_2x_2$. While the FE Mechanical Exam **includes the concept** ("linear, multiple" regression in the syllabus), you won't be asked to calculate a multiple regression by hand. Just know that **"multiple regression" means more than one x-variable** – and thus, multiple slopes b_1, b_2, etc. – and that the goodness-of-fit measures (R, R^2) still apply.

- *Polynomial or Nonlinear Fit:* "Curve fitting" can also mean fitting nonlinear relationships (quadratics, exponentials, etc.). If a straight line doesn't cut it (residuals show curvature), engineers might fit a higher-order polynomial or another function. **On the FE exam**, if a nonlinear fit is expected, the problem will usually guide you (e.g. "fit a second-order polynomial trend"). The default assumption is linear unless told otherwise. Remember, you can sometimes linearize a nonlinear relationship (e.g. take logs to fit an exponential) – but such transformations are beyond what FE typically requires.

- *Correlation Expectations:* In engineering experiments, it's rare to get a **perfect correlation** (R = ±1) due to real-world variability. An **R** of ±0.8 or higher is generally considered a strong linear relationship in many fields; R ~0.5 is moderate, and R near 0 means very weak linear relation. **R^2** is often reported in percentages: e.g. *$R^2 = 0.64$* means 64% of the variance is explained by the model. For the FE exam, if you see a very high R^2 (close to 1), expect the line to be a very reliable predictor; if R^2 is low, any predictions using the line will have large uncertainty.

- *Typical FE Problem Size:* You might get 3–6 data points in a problem (they won't give you 20 points to fit – too time-consuming). With two points, note that the "best-fit line" is just the straight line through them (so R = 1 in that trivial case, assuming the points aren't identical). With more points, the exam might provide sums needed for formulas (like $\sum x_i, \sum x_i^2, \sum x_i y_i$, etc.), or you can quickly compute them. Recognize that if data points lie exactly on a line (all residuals zero), $R^2 = 1$. If they're all over the place (a "shotgun" scatter), R^2 will be low. Often, exam questions use relatively nice numbers so that the line comes out neat (or at least estimate-friendly).

- *Outliers:* Be alert for any outlier data point – one that is far off the trend of the others. A single outlier can severely drag down the correlation and skew the slope. In an exam context, if a point looks way off the line formed by the others, a question might ask something like "what is the best-fit line **excluding** the outlier" or "identify the outlier's effect". Statistically, excluding an outlier typically **increases** R^2 (better fit to remaining points). The key is: **don't ignore an outlier unless directed**; include it in calculations unless the problem specifically suggests checking its influence. If included, know it will inflate residuals and reduce goodness-of-fit.

Special Notes (Calculator Use): The FE exam is **computer-based**, but you're given an on-screen searchable Handbook PDF and allowed to use a specific list of calculators. Make them work for you in regression problems:

- All approved calculators (like Casio fx-115/991 series, HP 33s/35s, TI-30X/36X Pro) have built-in stats functions. **Use them!** For instance, on the TI-36X Pro, you can enter paired data in STAT mode (select the linear regression option) and it will output the slope **b**, intercept **a**, and correlation **r** in one go. The Casio fx-115ES/991ES has a Mode for Regression (often labeled REG) where you input data points and similarly get $a, b,$ and r. This can save precious time and reduce arithmetic errors on exam day. *(Pro tip: always clear any old data from your calculator's stat editor before entering new data, to avoid using stray points from a previous problem. Also, ensure you select the correct regression mode – linear vs. quadratic, etc. For FE, it's linear unless stated otherwise.)*
- If you prefer or need to do it **manually**, break the work into clear steps: sum of x's, sum of y's, sum of x^2, sum of xy, etc. Write them down to avoid confusion. It's easy to make a mistake under time pressure, so after computing the slope b and intercept a, **quickly verify**: does your line roughly go through the middle of the data cloud? Does it yield positive y for positive slope (if trend is upward)? Double-check one point: plug an x from the data into $y = a + bx$ and see if the result is close to the given y – it should be in the ballpark for a reasonable fit. These sanity checks can catch algebra mistakes before you move on.
- Remember that while the **exam handbook provides the formulas** for regression (slope, intercept, etc.), it does **not** walk you through their application. Practice using the formulas and your calculator beforehand so you're comfortable both ways. If a problem gives you summary statistics (like sample means and variances), you might plug those directly into formulas rather than raw data. But

if raw data are given, the calculator route is usually fastest.

Explanation & Analysis (step-by-step):

The **least-squares regression line** is used whenever you have two related quantities and want a simple linear model to connect them. On the FE Mechanical exam, typical use-cases include: - **Data interpolation/extrapolation:** e.g. given a table of test results (say, torque vs. RPM or stress vs. strain at a few points), derive an equation so you can find the value at a point not explicitly given in the table.

- **Trend analysis:** e.g. determine if two variables have a strong linear relationship. The question might give you data and ask for the **correlation coefficient** or to comment on the fit's strength ("does the linear model appear valid?").

- **Engineering approximations:** e.g. fitting a linear model to nonlinear behavior over a small range. Often in mechanical engineering, a nonlinear relationship can be approximated as linear over a limited range (like small-strain stress-strain data approximated by Hooke's law). Regression quantifies the "best" linear approximation and how good it is.

Using regression on the exam comes down to **identifying that a linear fit is needed** (usually hinted by phrases like "best fit line," "linear trendline," or by the presence of multiple data pairs where no single formula is given). Once identified, apply the formulas or calculator procedure to get a and b, and perhaps R or R^2 if asked about goodness-of-fit. The result is a simple equation you can use to answer whatever the question asks (often plugging a value of x or y to find the corresponding other variable).

Analysis (How to Apply and Interpret the Formulas): Let's walk through an example in a stepwise manner, highlighting what each part of the regression does:

1. **Set up the Data:** Suppose you're given experimental pairs (x_i, y_i) for $i = 1,2,\ldots,n$. For concreteness, say these are measurements of **load** (x, in kN) vs **deflection** (y, in mm) for a beam. First, identify which variable is independent (x) and which is dependent (y). Here it makes sense that load is causing deflection, so x = load (input) and y = deflection (response). (On the exam, if not stated, use context or units to decide what "causes" the other.)

2. **Visualize (if possible):** Even though you might not plot points on paper during the exam, **envision the trend**. Are the points roughly forming a line? If yes, great – linear regression is appropriate. If they obviously curve, the exam might actually be expecting a different model or a piecewise analysis. But assuming a linear trend is intended, proceed.

3. **Compute Averages:** Find the mean of the x-values and the mean of the y-values: $\bar{x} = \frac{1}{n}\sum_{i=1}^{n} x_i$, and $\bar{y} = \frac{1}{n}\sum_{i=1}^{n} y_i$. These averages represent the "center of mass" of the data in the x–y plane. A fundamental property of the least-squares line is that it will **pass through** $(\bar{x}, \bar{y})$. This gives an intuitive anchor point for the line. (It's also a nice checkpoint: after you calculate the line, plugging $\bar{x}$ into $y = a + bx$ should yield $\bar{y}$ ideally, up to rounding error.)

4. **Calculate the Slope (b):** The core formula for the **slope** is:

$$b = \frac{\sum_{i=1}^{n}(x_i - \bar{x})\,(y_i - \bar{y})}{\sum_{i=1}^{n}(x_i - \bar{x})^2}.$$

This looks intimidating, but it's just a way to combine all data points into one meaningful ratio. The numerator $\sum(x_i - \bar{x})(y_i - \bar{y})$ is the **covariance** between x and y – it measures how x and y deviate together from their means. The denominator $\sum(x_i - \bar{x})^2$ is the **variance** of x – a measure of spread in the independent variable. So, **b = covariance/variance**. In simple terms, b tells us *"for a one-unit change in x, how much does y change on average?"* If x and y increase together (positive covariance), **b** comes out positive; if one increases while the other decreases (negative relationship), **b** is negative. A larger magnitude of **b** means a steeper trend.

Quick check: If you had two points, this formula reduces to the simple slope formula $(y_2 - y_1)/(x_2 - x_1)$. With more points, each contributes to this weighted average of slopes. Also note: if the data's x-values don't vary at all (all x are the same), the denominator is zero – you can't compute a slope (and indeed, you can't fit a unique line – you just have a vertical stack of points). The exam won't throw that pathological case at you without explanation, but it's good to know why variance in x is needed.

Calculate the Intercept (a): Once you have **b**, find the **y-intercept a** using:

$$a = \bar{y} - b\,\bar{x}.$$

This formula comes from rearranging $\bar{y} = a + b\,\bar{x}$. It ensures your line goes through $(\bar{x}, \bar{y})$. The intercept **a** is the model's prediction when $x = 0$. It often has a physical meaning (like if no load is applied, the predicted deflection is **a**). However, be cautious: if 0 is far outside your data range, **a** might be an extrapolation. For example, if your data covered loads 50 kN to 100 kN, the calculated **a** (at 0 kN) is an extrapolated value – it might not be actually valid, but mathematically it's where the line crosses the y-axis. The exam may ask for **a** explicitly, or you might need it to make predictions at given x values.

Now you have your regression line fully defined: $y = a + b\,x$**.** Write it out clearly. For instance, you might get something like $y = 0.120 + 3.45x$ (just an example) meaning at zero load there's a tiny initial deflection (0.120 mm), and each additional kN increases deflection by 3.45 mm. Always double-check units: 3.45 mm per kN, in this hypothetical case.

1. **Use the Line for Predictions:** With the formula, you can plug in any relevant x to predict y (or vice versa, solve for x given a y – though strictly speaking that's using the inverse line). The FE problems might directly ask "What is the estimated y at x = 75 kN?" or something along those lines. You'd substitute $x = 75$ into $y = 0.120 + 3.45(75)$ to get the answer. **Important:** Interpolate within the data range if possible rather than extrapolate beyond it, unless the question specifically is about extrapolation. Interpolation (predicting between known data points) is usually safer and more accurate than extrapolation (predicting beyond the data's range) because we assume linearity only over the tested range unless told otherwise. If you must extrapolate (say the question asks for a prediction at a value slightly outside the given range), answer with the linear model but mentally note the uncertainty.

2. **Evaluate Goodness of Fit – Correlation (R):** Often, exam questions might simply give you data and ask for the **correlation coefficient** *r* (or *R*). This value tells you how tightly the points cluster around a straight line. Calculate it using:

$$R = \frac{\sum(x_i - \bar{x})(y_i - \bar{y})}{\sqrt{[\sum(x_i - \bar{x})^2][\sum(y_i - \bar{y})^2]}}.$$

This is very similar to the slope formula, except the denominator now includes $\sum(y_i - \bar{y})^2$ (the variance of y). Essentially, it's a **normalized covariance** – normalized by both the spread in x and the spread in y. The result has no units (because the units cancel out in that ratio) and ranges from **-1 to +1**.

- If $R \approx +1$, it means *y* increases nearly perfectly linearly with *x* (points lie close to a line with positive slope).
- If $R \approx -1$, *y* decreases nearly perfectly linearly as *x* increases (points lie close to a line with negative slope).
- If R is near 0, there's little to no linear relationship – the points are a shapeless cloud, at least in terms of linear trend.

A quick qualitative way to think of R: it's the cosine of the angle between the vectors of deviations $(x_i - \bar{x})$ and $(y_i - \bar{y})$. If they line up perfectly (all points exactly on some line), cosine is ±1. If they're uncorrelated (no linear alignment), cosine ~0. You don't need that fact for the exam, but it explains why the formula has that form (dot product over product of lengths).

1. **Evaluate Goodness of Fit – Coefficient of Determination (R^2):** To interpret the **strength** of the fit in terms of variance explained, we use **R^2**. Simply square the correlation: $R^2 = (R)^2$. For a quick understanding: if $R = 0.9$ (which is a strong positive correlation), then $R^2 = 0.81$ or 81%. We'd say "81% of the variability in y is explained by the linear relationship with x." The remaining 19% is presumably due to other factors or inherent scatter. On the flip side, if $R = -0.3$ (a weak negative correlation), $R^2 = 0.09$ (9%). That means the linear model captures only 9% of the variance – essentially not useful; 91% of the variance is still unaccounted-for by the line. **In regression output, R^2 is often more emphasized than R**, because it directly tells you how useful the model is for prediction (higher R^2 = more of the signal captured by the model). Remember: a negative R and a positive R of the same magnitude give the same R^2 – high R^2 just means strong relationship, regardless of direction. So always pair R^2 with a check of the sign of **b** to know if it's an increasing or decreasing trend.

On the exam, you might not be explicitly asked for R^2, but if you calculate R, it's easy to square it if needed. Sometimes a question might give you R^2 and ask you to interpret it (e.g. "$R^2 = 0.95$ – comment on the fit." Answer: very good fit, 95% of variance explained, etc.).

1. **Check Residuals (Model Adequacy):** After fitting, especially if there's a part two of a question asking "Is a linear model appropriate?" or "What does the residual plot indicate?", you should consider residuals $e_i = y_i - \hat{y}_i$ (actual minus predicted). Compute a few if needed. By construction of least squares, the **mean of residuals is zero** (they cancel out on average). But their pattern can be revealing:
2. If residuals are all small (close to zero relative to the magnitude of y) and show no systematic change with x (no trends or cycles), then the linear model is doing a good job – any remaining error is likely random noise.
3. If residuals start positive and become negative (or vice versa) as x increases, it indicates a **curvature** that a straight line isn't capturing (maybe the true relation is quadratic, etc.).
4. If one residual is much larger than others in magnitude, that data point might be an outlier. The exam might ask how removing it would affect the line (generally, it could change **a**, **b**, and increase R^2 if the outlier was off the trend).
5. Sometimes residuals might increase in magnitude as x increases (fan-out pattern), indicating increasing variance – a detail usually beyond FE scope, but it's essentially heteroscedasticity (non-constant error variance). FE likely won't go there; just know a weird residual pattern = question the model.

In summary, **model adequacy** means *"Is my chosen model (like a linear fit) good enough to represent the data for practical purposes?"* For FE exam answers: if residuals are random and R^2 is high, yes it's good; if residuals have a trend or R^2 is very low, mention that the linear model may not be appropriate.

1. **Final Thoughts:** Use the regression line or correlation as needed to answer the question posed. If you're asked for an equation, present it clearly (rounded reasonably). If asked for a prediction, compute it carefully and include units. If asked for a measure of fit, state R or R^2 and explain what it means (e.g. "R = 0.98, which indicates a very strong positive linear relationship."). The exam might also include conceptual questions, like *"What is the significance of a correlation coefficient of 0?"* (Answer: means no linear correlation; knowing x doesn't linearly predict y). Or *"Why might you choose a linear model for data?"* (Answer: simplicity and if data appears approximately linear; plus if R^2 is high it justifies the choice).

Throughout, avoid common mistakes: **mixing up x and y** (be sure which is independent), **sign errors** in calculating b (if you get a negative b but an upward trend, something's off), and **unit mistakes** (especially if converting units, or forgetting that, say, an intercept might need physical interpretation). If you use the calculator's regression function, double-check that you correctly paired x and y inputs; one misplaced data pair can throw off the results. And finally, manage your time – regression is often just one part of a problem, so streamline your process (calculator use, quick formula recall) to leave time for interpreting the results.

Summary: You use regression to get a working equation from data and to measure how reliable that equation is. On exam day, a regression problem tests your ability to apply formulas or calculator features and interpret statistical measures in plain language (e.g. high R^2 = good fit). Practice a couple of examples beforehand, so you recognize when a question wants you to "play statistician" for a moment and you can execute the steps with confidence.

K02.T04.S05 – Goodness-of-Fit Metrics (R^2)

Principle Introduction – Subtopic: *Goodness-of-fit metrics* gauge how closely a regression model's predictions match the observed data. In simple linear regression (fitting a straight line to data), the

primary metric is the **Coefficient of Determination**, R^2. Key points to build intuition:

- **Regression Fit:** The goal of linear regression is to determine a line $y = a + bx$ that minimizes prediction errors (residuals) using the *least squares* method (minimizing the sum of squared residuals). Once we have this best-fit line, we need a **numeric score** to judge *how good* the fit is.
- **Definition of R^2:** R^2 is defined as the fraction of the data's variance (in the output y) that is explained by the regression model. It ranges from 0 to 1. An $R^2 = 1.0$ (100%) means **perfect fit** – the line passes exactly through every point (all variability in y is explained by x). An $R^2 = 0$ means the line is no better at predicting y than simply using the mean of y (no linear relationship captured).
- **High vs Low R^2:** In practice, a **higher** R^2 (closer to 1) indicates a strong fit: the data points hug the regression line and the model captures most trends in y. A **low** R^2 (near 0) indicates a weak fit: the data points are widely scattered around the line, and the model explains little of the variation. On exam day, if you see a high R^2 value, you can infer the linear model is effective; a low R^2 suggests the linear model isn't capturing the data pattern well.
- **Relationship to Correlation R:** The Pearson correlation coefficient R (also written as r) quantifies both the strength and direction of a linear relationship between two variables, x and y. Its values range from –1, indicating a perfect negative linear correlation, through 0, indicating no linear correlation, to +1, indicating a perfect positive linear correlation. The sign of R tells whether the trend is upward (+) or downward (–). The magnitude of R is related to fit quality; **its square is** R^2. In simple linear regression, $R^2 = R^2$ (literally the square of the correlation coefficient) and thus ignores the sign, focusing purely on goodness-of-fit. For example, $R = -0.8$ (a strong negative correlation) yields $R^2 = 0.64$, indicating 64% of variance explained (the fit strength) while the negative sign of R simply tells the slope is negative.

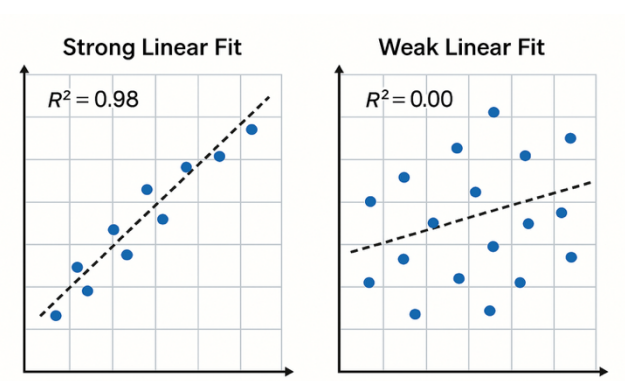

Figure: Visualizing goodness of fit. Left – a strong linear fit: data points closely follow the best-fit line, yielding $R^2 \approx 0.98$. Right – a weak (almost no) linear fit: data points are scattered with no clear linear trend, yielding $R^2 \approx 0.00$. The dashed lines represent the best-fit regression lines for each data set. A higher R^2 means the line accounts for most of the variation in Y, whereas R^2 near 0 means the line doesn't explain the data well at all.

Exam Handbook Search Cues (Not affiliated with or endorsed by NCEES): *linear regression*, *least squares*, *goodness of fit*, *correlation coefficient*, *coefficient of determination*, *residual*

Footnotes:

- Both R and R^2 are dimensionless – they have no units. They are pure numbers, since they represent ratios of variances or standardized covariance.

- R^2 values on the FE exam will fall between 0 and 1 for any legitimate regression scenario. A negative R^2 is theoretically possible if a "model" fits worse than using the mean of y (which can happen with forced non-intercept fits), but you can safely assume $0 \leq R^2 \leq 1$ in exam contexts.

- Linear regression assumptions include a linear relationship between x and y, and R^2 specifically measures how well a linear model captures y's variability. If the true relationship is non-linear, R^2 might be low even if the data follow a strong non-linear pattern – but typically exam problems focus on linear fits.

- The correlation coefficient R is often denoted r in statistics. On the exam or in the handbook, "sample correlation coefficient" refers to the same R. Remember that R has a sign (positive or negative correlation), whereas R^2 is positive (or zero) by definition.

- Quick check: If a model has $R^2 = 0.80$, then $1 - R^2 = 0.20$, meaning 20% of the variance in y is not explained by the model. Always interpret R^2 as a percentage of variance in the outcome accounted for by the predictor(s).

Variations, Related Forms, Typical Values:

- For simple linear regression (one independent variable x), the coefficient of determination R^2 is literally the square of Pearson's correlation coefficient R between x and y. In this case, $R^2 = \left(\mathrm{corr}(x, y)\right)^2$.

- For multiple regression (multiple input variables), R^2 generalizes to the fraction of variance explained by the multi-variable model. You might see it referred to as "multiple R^2." The interpretation (0 to 1 scale) is similar: closer to 1 means the model explains more of y's variance. The FE Mechanical Exam does not require computing multiple regression R^2 by hand, but understanding that R^2 still means "percent variance explained" is useful.

- *Beware of diminishing returns:* adding more variables to a model can only increase or maintain R^2, never decrease it. Thus, sometimes an adjusted R^2 is used in statistics to penalize extra variables. However, adjusted R^2 is beyond the scope of the FE exam; mention it only to clarify why R^2 is usually discussed in simple one-variable contexts on the exam.

- *Typical R^2 benchmarks:* An R^2 above ~0.9 is often considered an excellent linear fit in engineering data; around 0.5–0.7 indicates a moderate fit (some trend, but substantial scatter remains); and near 0 means essentially no linear trend. On the FE exam, you might get a scenario with two datasets or two models – you'd judge which has better fit by comparing their R^2 values (e.g., $R^2 = 0.85$ vs 0.45).

- *Other Goodness-of-Fit metrics:* One related metric is the **standard error of estimate** (essentially the standard deviation of the residuals). A smaller standard error means points lie closer to the line on average. While the exam **primarily uses** R **and** R^2 for regression fit questions, it's good to know conceptually that a lower

residual standard error aligns with a higher R^2. Another concept is the **residual plot** (graph of residuals vs. x) to check fit – if the regression is appropriate, residuals should look random (no pattern). These deeper diagnostics are usually beyond FE scope, but reinforce what R^2 is measuring.

Special Notes (Calculator Use): The FE-approved calculators can save you time in regression problems. Most advanced scientific calculators allowed (Casio fx-115 ES/MS or fx-991 series, TI-36X Pro, etc.) have a built-in statistics mode. You can enter paired data (x_i, y_i) and the calculator will compute the **linear regression** parameters and statistics – typically providing the slope b, intercept a, and the correlation coefficient r. For example, on the Casio fx-991EX, you would use the SD or REG mode, input the data points, then access the regression results (often A for intercept, B for slope, and r for correlation). Using these features, you could get R (and thus R^2) without manually crunching all the sums. **Practice this ahead of time!** If you prefer manual calculation, break the problem into steps: compute needed sums ($\sum x_i$, $\sum y_i$, $\sum x_i y_i$, etc.) using the calculator's memory, then plug into the formulas. But given time constraints, using the calc's stats function for regression is a smart move on exam day – just remember to square the reported r to get R^2 if needed, and watch out for rounding differences (carry sufficient precision in intermediate steps).

Explanation: The coefficient of determination R^2 tells you, in percentage terms, **how much of the variation in the outcome** variable y is explained by its linear relationship with predictor x. In an FE exam problem, after fitting a line (either given by the problem or determined by you), R^2 is used to **justify the goodness of that fit**. For instance, you might be given two possible trend lines through some data – the one with a higher R^2 is the better choice for a linear model. Another typical question: you have some summary statistics (like sums of squares) and need to compute R or R^2. You'd use the formulas to calculate R^2 and interpret it. The basic idea behind regression analysis on the FE is straightforward: find the best linear equation for data, then use R^2 to measure how reliable that linear model is. **Use case:** imagine you have experimental data of load vs deformation, and you fit a line. If R^2 comes out high (say 0.95), you can trust that line to predict deformation at intermediate loads fairly well. If R^2 is low (say 0.2), the linear model isn't capturing the behavior – perhaps the relationship is non-linear or too much noise is in the data. Thus, R^2 helps you decide *"Is a linear model acceptable here?"* or *"How confident can I be in predictions from this trendline?"* – exactly the kind of judgment the FE might test in a conceptual question.

Analysis (Step-by-Step): To understand R^2 deeply, let's break down the regression sums and see how R^2 is formed:

- When you perform linear regression, you start with the **total sum of squares** (denoted SST), which measures how much variation is in the original y data. SST is calculated as $\sum_{i=1}^{n}(y_i - \bar{y})^2$ – essentially the variance of y (up to the factor $n-1$). This represents the baseline variability in y if you had no model (just using the mean $\bar{y}$ as a predictor).
- The regression finds a line $\hat{y}_i = a + bx_i$ that produces **predicted** y values ($\hat{y}_i$). From this, we calculate the **explained sum of squares** $\text{SSR} = \sum_{i=1}^{n}(\hat{y}_i - \bar{y})^2$. SSR is variability in y that the regression *explains* by the linear trend with x. If $\hat{y}_i$ track the actual y_i closely, $\hat{y}_i$ vary with x in a way that accounts for most of y's variation.
- There will also be some leftover unexplained variation – the **residual sum of squares** $\text{SSE} = \sum_{i=1}^{n}(y_i - \hat{y}_i)^2$. This is simply $\text{SST} - \text{SSR}$, since total variation = explained + unexplained.
- Now, by definition, the coefficient of determination is $R^2 = \frac{\text{SSR}}{\text{SST}}$. This is a convenient ratio: it is literally the fraction of the total variance in y that the model explains. Since $\text{SSR} = \text{SST} - \text{SSE}$, we can also write $KeyFormula$:
  $R^2 = 1 - \frac{\text{SSE}}{\text{SST}}$. If the model is perfect, $\text{SSE} = 0$ (no unexplained error) so $R^2 = 1 - 0 = 1$. If the model is useless, $\text{SSR} \approx 0$ (explains nothing) so $R^2 \approx 0$ because $\text{SSE} \approx \text{SST}$. On the exam, you might be given SSE and SST to plug into this formula quickly, or even the regression output values directly.
- Each term in these formulas has a physical meaning: SST (units: $[y]^2$) is how much y varies naturally; SSE (units: $[y]^2$) is how much variation is still not captured by the regression; R^2 (dimensionless) is just one minus the ratio of those, so units cancel out – which is why R^2 is unitless and convenient for comparison. No matter if y is measured in psi, mm, or dollars, R^2 is just a ratio.
- **Common exam pitfalls:** (1) **Mixing up R and R^2:** If a question asks for the correlation coefficient and you accidentally give R^2 (or vice versa), you'll get it wrong. For example, if $R = 0.8$, that's a positive correlation, but $R^2 = 0.64$ – a very different number. Always clarify whether the problem is referencing R (often called "correlation coefficient") or R^2 ("coefficient of determination"). (2) **Forgetting the sign on R:** If asked to provide R, include the sign to indicate the direction of correlation (negative vs positive slope). R^2, on the other hand, is never negative, so don't attach a ± sign to R^2 values. (3) **Interpreting R^2 incorrectly:** Remember that $R^2 = 0.5$ does *not* mean the model is "50% correct" in an absolute sense – it means 50% of the variance in y is accounted for by the linear relation with x. The model could still have substantial errors in prediction even with a moderately high R^2. Conversely, a seemingly low R^2 could still be statistically significant if the dataset is inherently noisy. But for exam purposes, higher R^2 is simply better fit. (4) **Unit confusion:** Occasionally students think R^2 might carry the units of y or something – it doesn't. It's a ratio of variances; everything cancels. If you find yourself attaching units to R^2, that's a red flag – step back and re-compute. (5) **Causation vs correlation:** This is more of a conceptual warning – a high R or R^2 doesn't prove that changes in x *cause* changes in y. It only indicates a strong linear relationship. While causation questions are rare on FE, keep in mind R^2 is about fit quality, not a cause-effect proof.

DON'T MOVE ON YET!

Work Through Some Solid Practice Problems
while the Material of this Knowledge Is Still Fresh
THIS IS HOW THE CONCEPTS LOCK IN.

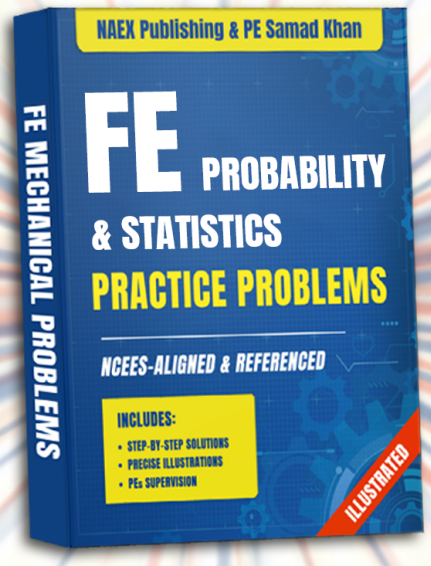

CLICK HERE TO PRACTICE

You'll be taken to our Discord Server, where the problems are located.

KNOWLEDGE 03

ETHICS AND PROFESSIONAL PRACTICE

- NAEX Publishing -

"This publication is not affiliated with or endorsed by NCEES".

Topic 01 - Codes of Ethics

Topic Introduction – Why Codes of Ethics Matter: In engineering, technical know-how isn't enough – you're entering a **profession** with critical responsibilities to society. A code of ethics is a formal **rulebook** that guides engineers to do the right thing, beyond just getting the right numerical answer. On the **FE Mechanical Exam**, ethics questions are typically conceptual. They often present a scenario where an engineer faces a moral dilemma (for example, being pressured to approve a design outside their expertise or noticing a safety risk being ignored) and ask what the engineer *should* do. These questions may not involve any calculations, but they carry heavy weight: understanding professional ethics is as crucial to public safety as understanding how to design a pressure vessel. In other words, a perfect technical solution done unethically can be just as harmful as a calculation mistake. **Expect** straightforward questions if you know the key principles – and potential traps if you don't. The good news is that the fundamental rules are clear and few in number. This chapter will equip you with the **fundamental canons of engineering ethics** (the core principles from codes of ethics like the NSPE Code of Ethics) so you can confidently navigate any ethics question on exam day. Let's break down what these principles are, why they exist, and how to apply them quickly and correctly under exam conditions.

K03.T01.S01 – Fundamental Canons of Engineering Ethics

Principle Introduction: Engineers across disciplines follow a set of fundamental ethical canons – think of these as the **"ground rules"** for professional conduct. These rules appear in the codes of ethics published by licensing boards and engineering societies, and they all emphasize similar themes:

- **Paramount duty to the public:** An engineer's highest obligation is to protect the public's health, safety, and welfare. Everything else comes second.
- **Competence and honesty:** Engineers should only do work in areas they're qualified for, and be truthful about what they can (and cannot) do. No cutting corners or misrepresenting facts.
- **Integrity in practice:** This means acting as a faithful agent for your clients and employers (loyalty and confidentiality), avoiding conflicts of interest, and rejecting bribery or fraudulent acts.
- **Professional responsibility:** Uphold the honor of the profession. If you see unethical or illegal practices, take appropriate action. Always conduct yourself in a way that **reflects well on the engineering field**.

These canons are the bedrock of every specific rule you'll find in various codes. If you know the **big ideas** above, you can reason through any scenario the exam throws at you, even if the question references a specific organization's code. Remember: all ethical codes for engineers boil down to *protecting people and doing the right thing*.

Exam Handbook Search Cues (Not affiliated with or endorsed by NCEES): *ethics, code of ethics, professional conduct, public welfare, conflict of interest* (use these keywords in the exam handbook's search to quickly find the ethics section for reference). *Hint:* On the computer-based exam, searching "ethics" or "conduct" will jump you directly to the professional conduct rules if you need a refresher.

Footnotes & Nuances:

- *Who is held to these codes?* These principles apply to **licensed Professional Engineers (PEs)** and, in spirit, to engineers in training (like FE candidates). On the exam, **you** are expected to know what is ethically required of a professional engineer, even before you earn the license.
- *Verbatim memorization vs. understanding:* You **don't need to quote** the code of ethics word-for-word on the FE Mechanical Exam, but you *do* need to recognize which actions violate the core principles. Focus on understanding scenarios – e.g. spotting a **conflict of interest** or a **safety hazard being ignored** – rather than reciting exact legal wording.
- *Ethics ≠ Emotions:* Ethical decisions should be based on these established canons, not personal feelings. The exam will always have one answer that aligns with the code's principles (even if another answer *feels* morally okay, it might not be the **most** ethical choice by the book). Stick to the fundamental canons as your criteria.
- *Not affiliated with or endorsed by NCEES:* This chapter interprets common principles from widely adopted engineering codes (like NCEES Model Rules and NSPE guidelines) in original words for study purposes. It's aligned with the exam scope **but not copied from any official document**. The goal is to help you learn ethically and legally sound practice without infringing on copyrights.

Variations and Related Codes: The **fundamental canons** show up with slight tweaks in various codes and laws:

- **NSPE Code vs. NCEES Model Rules:** The National Society of Professional Engineers (NSPE) Code of Ethics famously lists **six Fundamental Canons** that cover public safety, competence, truthful public statements, client/employer fidelity, no deception, and honorable conduct. The NCEES Model Rules (enforced by state licensing boards) cover the *same ideas* but organize them into obligations to the public, to employers/clients, and to other licensees. No matter the source, the core message is consistent – **protect the public, be honest, be competent, and act responsibly.**
- **Technical Society Codes:** Other professional societies (ASME, ASCE, IEEE, etc.) have their own ethics codes, but these are all *closely related siblings*. For example, an ASME member and an IEEE member are both expected to put safety first and avoid conflicts of interest. So if an FE exam question mentions any **professional or technical society's** code of ethics, don't panic – just apply the same fundamental canons.
- **Legal Requirements:** Many ethical duties are also **legal obligations**. State engineering licensure laws incorporate ethics: for instance, practicing outside your area of competence or neglecting public safety can lead not only to ethical violations but also to losing your license (legal penalty). Likewise, taking bribes or falsifying engineering documents isn't just unethical – it could be criminal. On exam day, however, you usually won't need to

distinguish whether it's "illegal" or just "unethical" – if it breaks a fundamental canon, it's **wrong**.

- **Emerging Topics:** Modern codes sometimes add guidance on things like sustainable development or whistleblower protection. While the FE Mechanical Exam is unlikely to dive deep into these, remember that **public welfare** isn't just immediate safety – it can include long-term impacts (like environmental responsibility). If it comes up, treat it as an extension of the first canon: protecting people and the planet for the public good.

Special Notes: No calculators needed here! For ethics questions, your **strategy** isn't plugging numbers into formulas, but rather **matching the scenario to the correct principle**. Practice a few questions where you read a short story and decide which canon applies. Also, get familiar with using the on-screen PDF **exam handbook**: if you blank out on, say, the rule about signing plans, a quick keyword search ("sign and seal" or "competence") will lead you to the right section of the handbook for a reminder. Essentially, treat the code of ethics like an open-book resource – but one you've studied enough that you rarely need to open the book.

Definition Passport: Fundamental Canons of Engineering Ethics

Plain-language definition: The *fundamental canons of engineering ethics* are the **six core principles** that every professional engineer should follow to ensure their work is done in an honest, safe, and responsible manner. They are the broad commandments of ethical engineering behavior, covering everything from public safety to personal integrity.

Where it matters (exam impact): You'll see these canons in conceptual questions asking what an engineer *should* do in a tricky situation. They show up anywhere the exam is testing your sense of professional responsibility – for example, identifying an ethical violation in a scenario or knowing the proper action when facing pressure to cut corners. Mastering these principles means you can quickly pinpoint the *ethically correct* answer on the FE Mechanical Exam, even if the question dresses it up in a story.

Pitfall or confusion point: Don't let *gut instinct* or workplace norms lead you astray. The biggest mistake is assuming something is okay because "everyone does it" or "my boss said so." On the exam, if it violates a fundamental canon (no matter how common in real life), it's **wrong**. Also, watch out for answers that *almost* address the issue but miss the key obligation – for instance, reporting a safety issue to your boss is good, but **not** enough if the public is in immediate danger (the canon would require you to go further to protect the public).

Micro-check: True/False: An engineer can approve a colleague's design outside of the engineer's own specialty, as long as the colleague is more experienced in that area. *(Think in terms of competence and public safety before you answer!)*

Explanation & Analysis – Applying the Fundamental Canons

Explanation (When and why to use these principles): The fundamental canons are your **ethical toolkit** for solving any professional dilemma problem on the exam. When a question begins with a scenario like, "You are an engineer working on X, and you discover Y," your first step is to identify which *ethical principle* is at stake. Are we dealing with a **public safety risk**? A **conflict of interest**? Pressure to work beyond one's **competence**? These canons guide you to the right course of action. Use them like a flowchart of moral decision-making: (1) **Safety first** – is anyone's life, health, or welfare at risk? (2) **Competence and authority** – are you (or is someone) being asked to work beyond qualification or to sign off on something outside your expertise? (3) **Honesty** – are there any false statements, hidden truths, or data manipulation involved? (4) **Loyalty vs. ethics** – is there a client's interest or an employer's order conflicting with the public good or with integrity? (5) **Integrity** – are there any bribes, gifts, or personal gains contaminating the situation? (6) **Professional reputation** – could this action disgrace the profession or break the law? By systematically checking through these, you can usually eliminate wrong answers and find the one choice that aligns with all the relevant canons. **In short:** apply the **fundamental canons** to see what an engineer *must do* (or not do) in the story given. The correct answer will never violate any of these core rules.

Analysis (Breaking down each canon and its meaning): Let's go through the classic six fundamental canons of engineering ethics one by one, decode their meaning, and point out how they might appear on the FE exam. These are paraphrased for clarity (each professional society or board may word them slightly differently, but the essence remains consistent):

1. **Hold Paramount the Safety, Health, and Welfare of the Public.** *This is numero uno for a reason.* An engineer's **primary obligation** is to safeguard people – whether it's the general public, users of a product, or workers on a project. In practice, this means **never knowingly do harm**. If you discover a design flaw that could injure someone, you must speak up. If your boss asks you to cut costs in a way that compromises safety, you must refuse. Public safety comes **before** anything else – including client demands or company profit. On the exam, any answer that ignores a clear risk to the public is *automatically wrong*. Typical question scenario: You find out that using a cheaper material could cause a component to fail sooner than expected. What do you do? The correct move, aligned with this canon, is to **address the safety issue** (redesign, inform stakeholders, etc.), not brush it under the rug. Remember, **"hold paramount" means top priority** – you put on your "public guardian" hat and do the right thing to protect others, even if it's inconvenient.

2. **Work Only Within Your Professional Competence.** In short, **do not sign up for work you're not qualified to do**. Every engineer has a defined skill set; pretending otherwise can endanger people and projects. For example, if you're a mechanical engineer, it's unethical to seal electrical engineering drawings, because you haven't been trained or licensed in that area. The FE exam may test this by presenting a scenario like: "A structural engineer is asked to approve an electrical plan because the electrical engineer is out sick." The ethical response? **Decline and insist on a qualified review.** This canon also means you should stamp/seal only documents you or those under your direct supervision prepared, and only if they meet standards. If you encounter an exam question about affixing your seal to a design you didn't fully review or don't understand, the answer is to **not do it** – it violates both competence and honesty. Keep in mind, competence isn't just degrees and titles; it includes being current in your field. So if a task is outside your expertise *or* you're rusty in that area, the ethical path is to get someone who is competent or educate yourself under supervision before proceeding.

3. **Make Public Statements That Are Objective and Accurate.** This canon is all about **honesty and transparency**, especially when communicating with the public. As an engineer, when you speak – whether it's a report, testimony, or even an advertisement – you must be truthful. No half-truths, no misrepresenting the facts to make your project look good. On the exam, this could appear as a question about an engineer asked to give a public estimate or assessment. For instance, imagine you're asked to sign off on a press release that claims a new product is "completely safe" despite incomplete testing. The ethical move: refuse to make **deceptive or unsubstantiated claims**. Instead, provide an objective statement (or none at all). Another angle: sometimes questions involve whistleblowing or reporting bad data. The key is that your **public statements** (including to authorities or in court) should be based on accurate data and **competent evaluation** of the subject. In practice, if you're not sure something is true, you either **verify it** or you **state the uncertainty** – never falsely assert or exaggerate. Engineers' words carry weight, and this canon ensures we **maintain public trust** by being rigorously honest.

4. **Serve Each Employer or Client Loyally and Transparently.** This one highlights **loyalty and trust** in professional relationships. Being a "faithful agent" means you put your client's or employer's best interests ahead of your own *private* interests – **but without violating Canon #1 (public safety)**. In simpler terms, you do your best work for them, keep their confidential information secret, and avoid conflicts of interest that would bias your judgment. A classic scenario: You're designing a process for Client A, and Client B (a potential competitor of A) approaches you with a lucrative contract offer. Ethically, you **must disclose** and likely refuse the new work if it compromises your duty to Client A – you can't serve two masters with conflicting interests without everyone knowing and agreeing. On the exam, watch for keywords like "conflict of interest," "proprietary information," or "moonlighting." For example, if a question says you've been offered a gift or side payment from a contractor while managing a project for your employer – alarm bells for **conflict of interest** should ring (loyal agents don't take bribes or side deals). The right answer will usually be to **come clean**: either reject the gift or fully inform all parties and recuse yourself if needed. Another situation: your employer asks you to do something marginally dishonest to win a contract (say, pad your resume or conceal a test result). The faithful agent principle never requires **blind obedience** – if the request is unethical or illegal, you must refuse, because ultimately being "faithful" to your employer does **not** trump being faithful to the public and the law.

5. **Never Engage in Misrepresentation or Deception.** Simply put, **engineers must not cheat, bribe, or lie** in any professional context. This canon overlaps with honesty but extends to all forms of fraud or deceit. It covers things like: don't falsify qualifications, don't inflate results, don't use tricky ploys to gain unfair advantage. For instance, you cannot bribe an inspector to approve your work, and you cannot knowingly use someone else's work without credit (that's deceitful, and often a legal issue too). On the exam, a deceptive act scenario might be subtle: e.g., an engineer who discovers a mistake in their design that no one else has caught – is it okay to quietly fix it without telling the client? Ethically, you should **inform the client** about significant errors even if you can correct them, because hiding it is a form of deceit and breaks trust. Another example: misrepresenting your credentials in a bid proposal. If a problem states you have an opportunity to win a contract by calling yourself an expert in something you're not, the answer is to **be truthful** even if it means losing the job. Expect that any answer choice suggesting "nobody will know, just do it" is *wrong*. Integrity is doing the right thing even when no one's watching – and the exam will test that understanding. Deceptive acts also include things like taking credit for others' work, or using insider information unethically. The safest route: if it's not **transparent and honest**, it's not allowed.

6. **Behave in Ways That Are Honorable, Responsible, Ethical, and Lawful, Supporting the Profession's Reputation.** This is a mouthful, but it boils down to **being a good role model for engineering**. Think of this as the "catch-all" canon that says: *behave in a way that if everyone in your field did the same, engineering would be trusted and respected.* It explicitly mentions obeying the law – so yes, you must follow all applicable laws in your practice (no shortcuts there!). It also means you should support **colleagues and the profession** in ethical ways: for example, giving credit where it's due, mentoring younger engineers, continuing your own education, and generally not doing anything that would make engineers look bad as a group. On the exam, this canon might appear indirectly. For instance, a question might describe an engineer discovering that a previous engineer on a project made critical errors. What's the honorable way to handle it? Likely, to inform the necessary parties **without** needlessly slandering the other engineer – fix the issue, but don't engage in a smear campaign. Another example: you witness unethical conduct by another engineer. The honorable action is to **report it to the appropriate board or authority** (after all, keeping silent would harm the profession and the public). Essentially, this principle reminds you that being an engineer carries a reputation – each of us is an ambassador of the field. So, when in doubt, ask: "Does this action uphold the dignity of the engineering profession?" If not, it's probably not the right choice.

Throughout all these canons, notice the common thread: **protect and inform**. Protect the people who could be affected by engineering work, and inform the relevant parties (clients, employers, public, boards) if something isn't right. If you carry those two ideas into every ethics question – *protect* whoever could be hurt, *inform* whoever needs to know – you'll align with the fundamental canons every time. As one of my own mentors used to say, *"Engineers don't just solve problems – we also speak up when something's wrong."* Keeping that duty in mind will guide you to the correct answer on exam day.

Topic 02 - Public Health, Safety, and Welfare

Topic Introduction: In the **Ethics and Professional Practice** domain of the FE Mechanical Exam, *Public health, safety, and welfare* is a core topic. This topic centers on an engineer's highest duties: protecting people and the environment from harm. Expect conceptual questions on exam day that present ethical dilemmas or decision-making scenarios involving safety. Typical question archetypes might ask, for example, what an engineer should do if asked to approve a design that might endanger the public, or how to respond if you discover unsafe practices at work. The key to these questions is understanding that **safeguarding the public** is paramount in engineering ethics – more important than profit, schedule, or even loyalty to your employer. What follows is a detailed breakdown of this topic's subtopics, each with the critical principles, definitions, and contexts you must master for the exam.

K03.T02.S01 – Engineer's Professional Obligation to Protect Public Health, Safety, and Welfare

Principle Introduction (Background & Intuition):

- Engineering is not just about technical skill; it's a public-serving **profession**. This means engineers have a **special responsibility** to society. Above all else, an engineer's primary obligation is to ensure that **people are safe, healthy, and not harmed in their overall well-being** by their work.
- This duty is often called the *"paramountcy principle,"* meaning public safety comes first – even before the interests of clients or employers. In practice, this means an engineer must never approve or turn a blind eye to a decision that would put people in danger.
- All major engineering codes of ethics (including state licensing laws and societies like NSPE) begin with this canon. On the exam, if a question scenario forces a choice between **public safety** and other considerations (cost, schedule, loyalty, etc.), **public safety wins every time**.
- This obligation extends to **public health** (preventing illness or health hazards), **safety** (preventing injury or death), and **public welfare** (the general well-being of the community, including environmental and property protection). In essence, engineers must act as guardians of the public interest whenever they design or make decisions.

Definition Passport: *Engineer's Paramount Obligation – Public Safety*

- **Plain-language definition:** Every licensed engineer must make the **safety, health, and welfare of the public** their **highest priority** in all professional actions. In other words, an engineer should *never* compromise public well-being for any other gain or pressure.

- **Where it matters (exam impact):** This principle appears in ethics questions whenever there is a conflict between public safety and something else. FE exam items might describe a scenario – e.g. an unsafe design feature, a client requesting a shortcut, or a hazardous condition – and ask what the ethical response is. Remember: **the correct action is always the one that protects people.**

- **Pitfall or confusion point:** A common misconception is thinking that an engineer's obligation to their employer or client could override public safety. **This is false.** No contract or directive can excuse risking the public. Another confusion point is underestimating who "the public" includes – it's *everyone* potentially affected by the project (not just direct users, but also neighbors, general community, and even future generations).

- **Micro-check:** True/False – If an engineer's client demands a cost-cutting change that could make a product less safe for users, the engineer is ethically bound to refuse. *(Think it through: the answer hinges on whether cost can trump safety.)*

Exam Handbook Search Cues (Not affiliated with or endorsed by NCEES): *"health, safety, and welfare"*, *"first responsibility"*, *"paramount"* – The exam handbook's ethics section explicitly states that an engineer's **first responsibility** is safeguarding the public. Search for these terms in the handbook to find the exact phrasing of this fundamental duty.

Footnotes: - **Scope:** *"Public"* means **anyone who could be affected** by the engineering work – not only those directly involved in the project. For example, if you're designing a boiler for a factory, "the public" includes the factory workers, people living nearby, and anyone who would be harmed if the boiler fails [^1]. - **Legal weight:** This paramountcy principle isn't just a suggestion – it's typically written into **state engineering laws**. Violating it (knowingly endangering the public) can lead to loss of licensure or worse [^2]. - **Synonyms:** In some ethics codes, you'll see phrases like "**hold paramount the safety…**" – they all convey this same idea of top priority. Keep an eye out for language like *"highest duty"*, *"paramount obligation"*, or *"first and foremost responsibility."*

Variations, Related Concepts, Typical Values:
While this subtopic is conceptual (no formula), it relates to many engineering practices designed for safety. For instance, engineers use **safety factors** and **design codes** (see K03.T02.S03) precisely to fulfill this obligation. A *Factor of Safety (FoS)*, for example, is a numerical cushion (often >1.5 or more in critical designs) ensuring structures or machines can handle loads beyond expected limits – this reflects designing with public safety in mind. Typical values for FoS depend on the application (e.g., building structures might use FoS ~2, while elevators use higher values) but the concept is universal: don't push materials or systems to their breaking point when lives are at stake. Another related concept is **"fail-safe" design** (designing systems that default to a safe state on failure) – again, aiming to protect people if something goes wrong. These technical measures are the practical side of upholding public welfare.

Special Notes: In exam problems, you won't need a calculator for this principle, but you might need to **recognize key terms**. For example, if the question mentions *"public welfare"* or *"safety"* in an ethics context, that's your cue that the paramountcy principle is being tested. Remember that the FE Exam's searchable handbook uses those exact words – practice using the search function quickly to pull up the ethics code if needed for confirmation.

Explanation & Analysis (Step-by-Step Thought Process):
Understanding this principle is straightforward: **protecting people**

comes first. But let's break down what it means in an engineer's day-to-day decision-making:

- **What it's used for:** This isn't a formula, but a guiding rule. It's "used" whenever you need to decide the right course of action in a grey area. For FE exam purposes, apply it to any scenario: if you suspect something could harm the public (even indirectly), the ethical approach is to address that risk, *even if it's inconvenient*. This could mean adding a safety measure, conducting extra testing, or refusing to approve something that isn't safe. On the exam, any answer choice that violates public safety is automatically wrong, no matter who else it seems to please.

Key elements:
Let's dissect the phrase **"public health, safety, and welfare."**

- **Health:** avoiding dangers to people's health (e.g. preventing exposure to toxic chemicals, ensuring water is not contaminated, etc.).
- **Safety:** preventing accidents, injuries, and fatalities (e.g. making sure structures won't collapse, machines have guards, electrical systems won't shock).
- **Welfare:** a broader term for general well-being – this includes things like environmental protection (because a polluted environment hurts public welfare), economic well-being (not causing financial ruin or property damage to others), and overall quality of life. Each of these factors must be safeguarded by engineering decisions. For instance, a new bridge design must ensure physical safety (it won't fail under load), health (perhaps by using materials that won't poison the environment), and welfare (it serves the community's needs without causing undue disruption).

Common Mistakes and Pitfalls: One typical mistake on exam questions is choosing an answer where the engineer *rationalizes an unsafe decision*. For example, an answer might suggest "Proceed with the design as-is because the client insists and will pay a bonus." This is a trap – no amount of client pressure or money justifies endangering the public. Another pitfall is misidentifying who counts as "the public." Even if an engineering project is for a private client, *other people* could still be affected. Always err on the side of caution: if *anyone* could be harmed, that's a public safety issue.

Sanity check / Limit test: If you're unsure whether something truly falls under public safety, ask: *"What's the worst that could happen to an innocent person if this goes wrong?"* If the answer is injury, illness, or death, you know the public safety obligation kicks in. Conversely, if the worst outcome is merely a financial loss or a missed business opportunity *with no safety impact*, then it might not be a public welfare issue (though other ethics or contract issues could still apply). This mental check helps keep your priorities straight under pressure.

Use vs. Sibling Concepts: Use this "public safety first" rule **instead of** any directive from a boss or client when they conflict. For instance, if a supervisor tells you to ignore a failing test result to stay on schedule, you must rely on the paramountcy rule rather than "following orders." Another related concept is **competence** – ensuring you only work within your area of expertise – because doing otherwise can also jeopardize public safety. But competence is a separate ethics topic; still, it feeds into safety (an incompetent design is an unsafe design).

Common Exam Traps:

- **"Just following orders" trap:** An answer choice might imply the engineer is excused from responsibility if someone else (like a manager) made the call. In ethics, that's not acceptable – you can't duck the public safety obligation by blaming someone above you.
- **"It's okay if no one finds out" trap:** Another wrong answer might suggest that if a flaw is unlikely to be noticed, it's fine to ignore it. The exam expects you to spot that as unethical – safety issues must be addressed, not hidden, *even if* the chance of discovery or accident seems low.
- **Overconfidence trap:** Thinking "I know it's slightly unsafe, but it'll probably be fine because I'm an expert" is also a mistake. The code doesn't allow playing odds with safety. If something isn't up to standard, you fix it or report it – period.

In summary, **Engineer's Obligation to Protect Public Safety** is the cornerstone of engineering ethics. Every other professional duty takes a back seat to this one. As you practice exam problems, train yourself to immediately flag any situation where public health, safety, or welfare could be compromised. The correct ethical action will be the one that *eliminates or mitigates the danger*. This might mean redesigning a component, refusing to approve a shoddy plan, installing extra safety features, or communicating concerns to those who can address them. Think of yourself as both an engineer and a guardian: your work isn't truly successful unless it's safe for everyone it affects.

K03.T02.S02 – Ethical and Legal Responsibilities to Report or Mitigate Unsafe Practices

Principle Introduction (Background & Intuition):

- It's not enough for engineers to **avoid causing** safety problems themselves; they also have a duty to **take action when they see unsafe or unethical practices** by others. This subtopic is about **speaking up** and **intervening** if public safety is in jeopardy.
- In professional life, you might encounter situations where someone is cutting corners, violating standards, or simply making a mistake that creates a hazard. **Ethically and often legally, an engineer must address such situations**. This could mean reporting the issue to a supervisor, refusing to comply with an improper order, or notifying regulators. In extreme cases, it could even mean whistleblowing to outside authorities if internal channels don't work.
- The FE Exam may present scenarios like: *"You discover that a coworker falsified a safety test report,"* or *"Your client insists you ignore a construction flaw,"* and then ask what you should do. Knowing this principle, the answer will involve **mitigating the danger or reporting the misconduct** (not staying silent).
- Importantly, this responsibility has two components: **preventing harm if you can** (mitigation) and **reporting violations** if they've occurred. Mitigation might mean actively correcting an unsafe design or halting a process until it's fixed. Reporting means informing the

appropriate authority if someone is breaking the rules or laws that keep the public safe.

Definition Passport: *Duty to Report and Mitigate Unsafe Practices*

- **Plain-language definition:** Engineers are ethically and legally obligated to **act** when they become aware of unsafe conditions or unethical practices that could endanger people. This means you must **report** clear violations of safety standards or laws, and/or **take steps to mitigate** (reduce or eliminate) the danger. Silence or inaction in the face of a hazard is not an option.

- **Where it matters (exam impact):** Look for exam questions where an engineer observes something like a design flaw, construction shortcut, or colleague's misconduct that poses a risk. The test will probe whether you know the correct response: generally, first alert the responsible parties (e.g. your employer/client) and *if they do not address it*, escalate to higher authorities (like a licensing board or regulatory agency). Many questions boil down to "what is the MOST ethical action?" The presence of a **public safety risk** means the answer involves reporting or fixing that risk, even if it's inconvenient.

- **Pitfall or confusion point:** One pitfall is misunderstanding **chain of command vs. duty to public**. Ethically, you usually try to resolve issues internally first (tell your immediate supervisor or the engineer in charge about the problem). However, if the issue is ignored or if the person responsible *is* the problem, you **must go beyond** the chain of command. Some engineers worry about loyalty or retaliation – but the code explicitly protects the public first. Another confusion: thinking that if you didn't cause the problem, you can wash your hands of it. Wrong – as a professional, if you **know** about a serious hazard, you inherit a responsibility to do something (at least to report it to those who can fix it).

- **Micro-check:** Yes/No – If an engineer finds that a contractor on their project is using substandard materials which could lead to structural failure, should the engineer report this, even if the contractor is a friend and begs them not to? *(Consider the ethical duty vs personal relationships.)*

Exam Handbook Search Cues (Not affiliated with or endorsed by NCEES): *"overruled", "public safety", "report", "violations" – In the exam reference, the ethics rules include provisions about what to do when your professional judgment is ignored in a way that could harm the public and what to do when you know of rule or law violations by another engineer. Searching for terms like "overruled," "public safety," and "report" will take you to that section.*

Footnotes:

- **Whistleblowing:** The term *"whistleblower"* refers to someone who reports wrongdoing, often to outside authorities. Engineering ethics essentially expects you to be a whistleblower if that's what it takes to protect the public [^3]. Many jurisdictions have **whistleblower protection laws** to shield you from retaliation (firing, harassment) when you report safety violations – a reassurance that doing the right thing is also protected by law. On the exam, you won't need the legal details, just the principle that you *should* report.

- **Mitigation vs. Reporting:** Mitigation means *fix it if you can*. For example, if you discover a calculation error that makes a design unsafe, the first step is to correct the design. Reporting becomes critical when you encounter **willful negligence or misconduct**, or when you lack the authority to directly fix the issue. In many cases both happen: you try to mitigate (say, stop construction on a faulty design) and you report the issue to prevent future occurrences.

- **"Such other authority as appropriate":** The ethics code often says to notify your employer/client **and other appropriate authorities**. Who are these authorities? It could be the company's safety officer, the project owner, the state engineering board, OSHA, or even emergency services if it's an imminent danger. The key is: *don't keep it to yourself*. Make sure someone with power to address it knows about the hazard.

Variations, Related Forms, Typical Scenarios:

This duty can manifest in various ways:

- **Professional Judgment Overruled:** One scenario is when an engineer's sound recommendation (e.g., "we need to reinforce this beam or it might fail") is overruled by a non-engineer manager or client to save time or money. Ethically, the engineer must **object and escalate**. Ethically, if your well-founded safety recommendation is ignored in a way that could endanger the public, you are expected to inform your employer or client and, if necessary, appropriate regulatory authorities. On the exam, an answer might be "Inform your supervisor in writing that the design is unsafe and, if ignored, notify the state board." That captures the correct action.

- **Discovering Violations:** Another variation is discovering after the fact that someone violated rules (for instance, you find out a colleague signed off on work outside their competency, or a contractor is violating building codes). Likewise, if you become aware that a licensed engineer has seriously violated rules or laws governing practice, you're expected to report that concern to the licensing board or another appropriate authority rather than ignore it. In exam terms, that means the engineer should **formally report** the violation rather than ignore it or cover it up.

- **Stopping Work:** The ultimate mitigation is **refusing to participate in or halting a project** that is unsafe. Engineers actually have the authority (and duty) to stop work if continuing would put lives at risk [^4]. For example, if as a field engineer you see a critical flaw at a construction site, you can issue a stop-work order until it's fixed. Exam questions might imply this by asking what to do if you notice something dangerous during construction – the ethical answer: *stop the work and get it corrected*, even if the schedule suffers.

- **Cooperating with Investigations:** If a safety incident or an ethics violation is being investigated (by the company or the board), engineers must cooperate fully and honestly. This is another facet: once you report something, be prepared to provide information. On the exam, this is less likely a direct question, but it underpins why honesty and documentation matter.

Special Notes: When it comes to using your exam-approved calculator, there's obviously no direct calculation here. However, one practical note: **documenting your concerns in writing** is often advised in real life (and sometimes mentioned in answers). For instance, writing an email or memo to your supervisor saying "I believe the failure to heat-treat these parts could cause a safety hazard" creates a paper trail. While you won't have to write an email in the exam, if an answer choice mentions *documenting the issue* and informing higher-ups, that's usually a solid action. It shows you're serious and provides evidence you raised the concern, which is both ethically and legally wise.

Explanation & Analysis (What to do and why):
Let's analyze this duty step-by-step, as if approaching an exam scenario:

- **Recognize the Red Flags:** First, identify that you're dealing with an unsafe practice or ethical violation. Examples include: use of incorrect or substandard materials, falsified test results, ignored safety alarms, unqualified persons signing off on designs, or instructions to bypass safety protocols. On the FE exam, such details are the hints that *"Action is required."*
- **Initial Action – Internal Report:** The professional approach usually starts internally. If you're an employee, bring the issue to your immediate supervisor or the person in charge of safety. If you're a consulting engineer, inform the client (unless the client themselves is engaging in malfeasance – then you might skip to external). The **goal** is to give the responsible parties a chance to correct the problem. Often, ethical codes instruct engineers to first notify their employer or client, and then escalate the issue to any additional authorities who are in a position to address the problem". That implies *first* inform the people directly involved, *then* others as needed.
- **Escalation – External Report:** If the internal route does not resolve the danger (say your boss says "Ignore it" or you suspect they *are* the culprit of the unsafe practice), you must escalate. **Who do you escalate to?** Common "appropriate authorities" are: the state **engineering licensing board** (especially if a licensed engineer is violating rules), relevant **regulatory agencies** (like OSHA for workplace hazards, EPA for environmental hazards, city building department for construction code issues), or in some cases law enforcement (if laws are being broken and public is in immediate danger). The engineering board is a key one – they can discipline licensees for ethics violations, so reporting there is both an ethical requirement and often a legal one under licensure laws.
- **Mitigation – Taking Direct Action if Possible:** Alongside reporting, if you have the ability to **mitigate the risk immediately**, do so. For instance, suppose you are the supervising engineer at a plant and notice a test gauge indicates a pressure vessel is at risk of explosion. Ethically, you don't *only* fill out a report and send it up the chain; you also should **shut down the equipment** or evacuate the area as needed to prevent harm. In a design context, mitigation might mean redesigning a faulty component or adding a safety factor. The principle is: **reduce the danger right now** if it's within your power, then follow through with reporting to ensure long-term correction and accountability.

Term-by-term breakdown (if this were an equation):
Think of it this way – "Report or mitigate unsafe practices" has key elements:

- *Report* means inform someone with oversight authority (employer, board, etc.)
- *Mitigate* means do something to lessen the risk (engineering fix or stop-work).
- *Unsafe practices* covers anything from code violations, illegal acts, to honest mistakes that pose hazards.
- *Ethical and legal responsibilities* implies it's not just a moral choice; rules and laws expect you to act. In fact, most states' laws say failing to report a known violation by another engineer *itself* is an ethics violation.
- **Emphasizing Legal vs Ethical:** Ethically, engineers should be proactive in ensuring safety. Legally, there can be consequences for not reporting certain things. For example, if a bridge collapses and it comes out that an engineer on the team knew about a serious defect but stayed quiet, that engineer could face legal liability or disciplinary action for negligence. The FE exam could frame a question as: "Engineer A knows Engineer B is practicing with an expired license or ignoring safety codes; what should A do?" The answer: A must report B to the board (legal requirement) – it's not just a suggestion.

Common Exam Traps and Errors:

- **Staying Silent:** If an answer suggests doing nothing ("Since it's not your project, keep out of it"), that's a red flag – *wrong answer*. The only time an engineer might not be obligated to act is if the issue is outside their knowledge *and* they don't actually have reason to believe something's wrong. But exam scenarios will make it clear that you *do* have reason.
- **Confronting in an unprofessional way:** Another trap could be an answer that is too drastic too soon, like "Go straight to the newspapers." Generally, the professional step is not to make a public scandal unless all other channels fail. The exam expects you to know the proper hierarchy: internal -> board/regulators -> as a last resort, perhaps public warning if immediate danger. So if an option is "Immediately hold a press conference," that's likely not the best unless the scenario is truly imminent danger and no one else will act. Usually, *report to authorities* suffices.
- **Retaliation fear:** A subtle trap is an answer that rationalizes not reporting because you fear losing your job or being sued for defamation. While those fears can be real in life, the ethics code doesn't consider them valid excuses. So any answer that prioritizes the engineer's personal interest (keeping their job) over blowing the whistle is not the ethical one.
- **Consequences of following this duty:** It's worth noting (for your understanding, though not directly tested) that most ethics codes say engineers **should not be disciplined by their employer** for upholding public safety. In other words, an employer firing an engineer for refusing to do something unsafe is themselves acting unethically (and possibly illegally). This underlines that, ultimately, *the law backs the ethical engineer*. If you report something in good faith and it turns out to be an issue, you did the right thing. If it turns out to be a false alarm but you genuinely thought it was a danger, you're also generally protected as long as you were honest and reasonable.

Wrap-up Example: Imagine you're working on a mechanical installation and notice the contractor has substituted a cheaper bolt that doesn't meet the specified strength standard. You raise the concern to your project manager (internal report). If the manager dismisses it ("It'll be fine, don't worry"), you insist – maybe escalate to the engineering director or the client (further internal). If still ignored and you truly believe that bolt could fail and hurt

someone, your duty is to contact an authority – perhaps the local building inspector or your state engineering board – and report this unsafe practice. It might feel uncomfortable, but remember the previous subtopic: **public safety is paramount**. Reporting an unsafe practice is simply an extension of that rule – it's how you *enforce* the paramountcy of safety when others aren't following the rules. On the FE exam, when in doubt, choose the answer that involves **speaking up to the right people** and **refusing to be complicit in something dangerous**.

K03.T02.S03 – Role of Regulations, Standards, and Codes in Safeguarding the Public Interest

Principle Introduction (Background & Intuition):

- Laws, regulations, standards, and building codes are the *tools society uses to ensure engineering is done safely*. As an engineer, part of your ethical (and legal) duty to the public is to **know and abide by these rules**. This subtopic is about recognizing why these codes and standards exist and how they factor into ethical practice.
- **Building codes, safety regulations, and engineering standards** are essentially accumulated wisdom and requirements that prevent disasters. For example, structural building codes specify load requirements so buildings don't collapse in storms or earthquakes. The Occupational Safety and Health Administration (OSHA) has regulations to keep workplaces safe for employees. There are fire codes, electrical codes (like the National Electrical Code), pressure vessel codes (ASME), and many more – each designed in response to hazards that history has taught us to control.
- On the FE exam, you won't need to memorize specific code numbers or provisions, but you *will* need to demonstrate an understanding that **following relevant codes and standards is mandatory** for ethical practice. A typical question might be: *"An engineer is asked by a client to deviate from the building code to save money. What should the engineer do?"* The correct answer: refuse to violate the code (and explain that doing so would endanger public safety and break the law).
- Another angle: They might ask why licensure is required for practicing engineers or why certain designs must be certified – it's because of public protection. **Licensing laws** themselves are regulations to ensure only qualified individuals design critical systems. All these regulations form a framework safeguarding the public interest.

Definition Passport: *Regulations, Standards, and Codes – Safety Net for the Public*

- **Plain-language definition: Regulations** and **codes** (like laws, building codes, OSHA rules) are legally enforced requirements, and **standards** (like those from IEEE, ASME, ASTM, etc.) are widely accepted engineering guidelines. Together, they set minimum safety and quality benchmarks that engineers must meet or exceed to protect the public. Adhering to these is both an ethical obligation and often a legal requirement for engineers.

- **Where it matters (exam impact):** Exam questions may present a scenario where compliance with a code or standard is in question. For instance, *"Your design calculations show a factor of safety below what the code requires, but the client wants to proceed anyway."* Or *"An engineer is considering using a new material not covered in the standard – what should they do?"* The expected knowledge: **Never ignore mandatory codes**. If something isn't up to code, the solution is to redesign or seek a proper exemption through official channels (if available), not to proceed regardless. Also, be aware that *codes are often legally binding*. The FE exam might include a conceptual question about the purpose of building codes or the role of standards – the answer will tie back to ensuring public safety, consistency, and reliability in engineering work.

- **Pitfall or confusion point:** One confusion is the difference between **standards and codes**. Simply put, a **code** often has legal authority (usually adopted into law by a government body – e.g., *International Building Code* is adopted by many jurisdictions as law). A **standard** might be voluntary or industry-accepted guidelines (like ASTM material standards or ASME guidelines) – some standards become codes when referenced by law. For exam purposes, any well-known standard referenced likely implies something you *should follow* for good practice or something you *must follow* if it's integral to safety. Another pitfall is thinking **"engineering judgment can override code."** No – while engineering judgment is important, it cannot contradict a law or code requirement. If a code says minimum factor of safety = 2.0 for that structure, you can't ethically choose 1.5 because you believe it's enough. You must follow the code or, if you truly believe the code is overly conservative in a specific instance, you'd have to get a variance/exception through proper authority (and that's rarely within the scope of an exam question).

- **Micro-check:** True/False – An engineer sealing design plans for a public building can ignore parts of the building code if, in their expert opinion, those parts are not necessary for safety. *(Think about legal obligations and the engineer's ethical scope to deviate.)*

Exam Handbook Search Cues (Not affiliated with or endorsed by NCEES): *The ethics rules in the reference include requirements about when you may sign and seal documents—for example, they emphasize that you should only seal work that meets accepted engineering standards and protects the public. Keywords like 'sign and seal,' 'standards,' or 'safeguard' will help you locate that section in the handbook.*

Footnotes:

- **Compliance is Mandatory:** By law, an engineer *must* follow any applicable building codes and regulations for their project. If you don't, you're not only endangering people but also breaking the law. From an ethical perspective, rule of conduct explicitly states you shouldn't seal plans that don't meet standards [^5]. So on the exam, any suggestion of "just this once, we can skip the code" is a big no-no.

- **Common Regulations/Standards:** For mechanical engineers, some common ones include the **ASME Boiler and Pressure Vessel Code** (for pressure equipment safety), the **National Electrical Code (NEC)** (for electrical safety, often enforced as law), **NFPA codes** (fire safety standards), **ASCE/ACI codes** for civil structures (if your work overlaps structural), and **OSHA regulations** for equipment and workplace safety. You aren't tested on memorizing these, but you should recognize names like OSHA or building code as synonyms for safety requirements. If a question mentions an acronym you don't know, context usually tells you it's a regulatory or standard body. Treat it as "something the engineer should comply with."

- **Standards evolve:** Engineering standards and codes are not static; they update, usually after new insights or accidents. Ethically, engineers are expected to **stay up-to-date** with the codes in their field. If a code changed last year and you design to the old one out of ignorance, that's on you. For the FE exam, you won't be quizzed

on specific code updates, but the principle is that part of professionalism is continuous learning to keep current with safety standards.

Diagram/Table Passport: Below is a brief table of **Examples of Regulations and Standards** relevant to public safety in engineering. (This is *not* exhaustive – just a few illustrations. It's provided for context, and you do not need to memorize it; instead, understand the types of entities and rules that exist.)

Table: Key Safety Regulations and Standards (Examples)
These examples show how various codes/standards contribute to public welfare in engineering:

Regulation / Standard	Focus (Public Safeguard Role)
International Building Code (IBC) – model code adopted by local governments	Structural safety for buildings (e.g., proper loads, materials, fire exits) to prevent collapses and ensure safe evacuation in emergencies.
OSHA Regulations (Occupational Safety & Health Administration)	Workplace safety standards (machine guards, noise limits, chemical exposure limits, etc.) to protect workers from accidents and health hazards.
ASME Boiler & Pressure Vessel Code (American Society of Mechanical Engineers)	Design and fabrication rules for boilers, pressure vessels, and tanks to prevent explosions and leaks (these standards are often legally required by jurisdictions).
NFPA Codes (National Fire Protection Association) – e.g., NFPA 70 "National Electrical Code"	Fire and electrical safety; NEC (NFPA 70) provides requirements for safe electrical design/installations to prevent shocks and fires. Other NFPA codes cover things like sprinkler systems, fuel gas safety, etc.
ANSI/ISO/ASTM Standards (Various organizations)	Consensus technical standards (e.g., material strength specs, testing methods, quality control) that ensure reliability. Not laws by themselves, but often referenced by codes or contracts, thereby indirectly acquiring authority. Engineers follow these to ensure consistency and proven safety margins in designs.

Note: This table is a general guide and not part of the official exam references. It's meant to illustrate how different regulations and standards each address certain safety aspects. On the FE Exam, you might simply see a reference like "according to building code" or "OSHA limits," and you should understand that the engineer must comply with those requirements.

Typical Exam Moves:

When faced with an exam question dealing with codes or standards, here's how to approach it:

1. **Identify the Code/Standard in Play:** If the problem mentions a specific code (e.g., *"building code requires X"* or *"per OSHA standard Y"*), lock onto that detail. It means the scenario revolves around a requirement that the engineer must respect.

2. **Check for Compliance in the Scenario:** Is the engineer in the scenario being asked to do something that **violates** the code/standard? Or have they discovered that a design doesn't meet the code? If yes, that's the crux – compliance is not optional. Ethically, the engineer must not approve or continue with a non-compliant design.

3. **Decide the Correct Ethical Action:** Usually either (a) modify the design/practice to meet the code, (b) refuse to proceed until it's up to code, or (c) seek guidance/variance if the code has provision for alternative solutions (rare in questions). Essentially, the right move is to *uphold the code's requirement*. Any answer that suggests ignoring, bending, or hiding the violation is wrong.

4. **Remember Public Interest:** Understand *why* the code exists – to protect something (safety, health, property). If a question asks something like, *"Why are engineering designs required to conform to standards?"* the answer should be along lines of *"to ensure public safety and welfare through proven best practices."* This ties back to subtopics S01 and S02: following codes is one way engineers fulfill their obligation to the public and avoid unsafe practices.

Analysis (Term-by-term Insight):

- **Regulations/Codes:** These carry the force of law. For example, state laws will require that buildings are designed according to a building code. If an engineer signs off on a design that doesn't meet code and it fails, they could be legally liable (negligence per se, because they broke the law). Ethically, the requirement to follow licensing laws and professional rules is non-negotiable; ethics codes explicitly require engineers to comply with applicable laws and regulations. So "regulation" implies *must do*.

- **Standards:** These might be voluntary or industry-driven, but they often represent collective safety wisdom. For instance, ANSI standards on machine tool safety aren't laws, but if you ignore them and someone gets hurt, you'd have a hard time defending your design. On exam questions, if a particular standard is referenced, treat it as the **expected level of care**. E.g., *"According to the standard, a certain test must be done"* – then ethically, you should ensure it's done.

- **Safeguarding Public Interest:** This phrase means anything done in engineering should consider the **public good** – safety, health, environmental protection, etc. Regulations and standards formalize the minimum acceptable level of public protection. So when you

adhere to them, you are by definition safeguarding the public interest. Conversely, flouting them usually equates to endangering the public interest. The exam may expect you to connect these dots in an answer explanation: e.g., *"the engineer must follow the building code because those requirements safeguard public safety in the structure."*

Common Pitfalls in Application:

- **"My project is unique; code doesn't apply"** – Engineers sometimes think that if something isn't explicitly covered by a code, they have carte blanche. Ethically, if no specific code applies, you still must use good judgment and analogous standards. And if a code *does* apply, you can't claim uniqueness to avoid it.

- **Misinterpreting Codes:** Another trap is not understanding the code properly. On the exam, they won't quiz you on code interpretation minutiae, but for instance, an answer choice might reflect a misunderstanding like mixing up *allowable stress* vs *ultimate strength requirements*. While you won't calculate those here, the safer route is: if unsure, err on the side of **over-designing for safety** rather than under.

- **Economic Pressure:** There might be an answer where the engineer chooses a cheaper solution that doesn't meet code, thinking short-term cost saving is okay. This is a direct conflict with ethics. The pitfall is failing to justify safety measures when they cost more. In real life, you'd explain to the client: following the code is not optional and actually protects them from liability too. On the test, just align with the code, cost be damned – ethical decisions are not cost-benefit analyses when safety is involved.

- **Outdated Standards:** Using outdated info can be a subtle angle – e.g., an engineer learned an old standard and hasn't kept up. The expectation is that professionals refresh their knowledge. If a question hints that a new code edition has stricter criteria, the engineer should adopt the stricter criteria.

Link to Adjacent Topics: This subtopic links back to why licensure exists (ensuring engineers know and follow these standards) and forward to professional practice issues like contracts. For instance, a contract might specify adherence to certain standards – breaking that is not only unethical but breaches the contract. However, under ethics, even if a client *wanted* you to not follow a standard, you can't agree to that in a contract because it would be a void or unenforceable agreement (you can't contract away public safety obligations). Adjacent topics in ethics might include *Codes of Ethics in professional societies* (which echo the requirement to follow regulations) and *Professional Liability* (if you don't follow standards and something goes wrong, you'll be liable).

Conclusion of Analysis:

Following regulations, standards, and codes is essentially about **engineers not reinventing the wheel poorly**. These rules are there because at some point, experience (often hard-earned through accidents or failures) taught us what minimum safety looks like. As an engineer and FE examinee, internalize that **good engineering = compliant engineering** when it comes to public safeguards. In exam terms, if you see an ethical issue tied to a code or standard, the correct resolution is straightforward: **comply or don't proceed**. There is always an ethical path that involves doing things right, even if it means telling a client "no" or spending more time and money to adjust the design. And remember, *if someone pressures you to break the rules, that loops back into subtopic S02:* you then have a duty to resist and report such unsafe requests. All these principles reinforce each other.

Topic 03 - Ethics and Professional Practice: Intellectual Property

Topic Introduction: Intellectual property (IP) covers the legal protections for creative and innovative works—an essential aspect of professional practice. In engineering, knowing how to secure your designs and respect others' rights is crucial. This topic matters on exam day because IP questions often appear as conceptual scenarios. You might be asked which type of protection applies to a new device, design, or piece of information, or what an engineer should do to **protect or avoid misusing intellectual property**. These questions don't involve calculations, but they test your understanding of **ethical and legal responsibilities**. As a practicing engineer, I quickly learned that IP isn't just for lawyers—deciding whether to patent a mechanism or keep a process secret, or whether sharing a client's design violates confidentiality, is part of the job. Let's break down the types of intellectual property and how they apply to engineering situations.

K03.T03.S01 – Definition and Categories of Intellectual Property

- **Intellectual property** refers to creations of the mind—intangible assets like inventions, creative works, designs, and symbols that have value. It is *"property"* in the sense that it can be owned and legally protected, much like physical property, except it's **intangible** (you can't touch a patent or a copyright itself, only its *physical manifestations*).
- There are **four main categories** of intellectual property protection, each guarding a different type of creation: **patents**, **trademarks**, **copyrights**, and **trade secrets**. Every one of these is aimed at preventing unauthorized use or copying of the protected material, but they operate in different ways.
- **Engineers encounter IP regularly:** for example, when designing a new mechanical device (potentially patentable), developing a product logo or brand (*trademark* issues), writing software or technical manuals (*copyright* applies), or handling a proprietary manufacturing process (*trade secret* considerations).
- **Exam spotlight:** Expect conceptual questions asking you to identify the appropriate category of IP for a given scenario or what actions are ethical regarding confidential information. For instance, a question may describe an engineer moving to a new job with knowledge of a proprietary process and ask what the ethical duty is (answer: **maintain confidentiality** because it's a trade secret of the former employer).

Definition: *Intellectual property* is any **intangible creative work** or idea that can be owned and protected by law. This includes technological inventions, designs, artistic and literary works, logos and brand identifiers, and specialized business information. In short, it's the **legal concept of ownership over creations of the mind** rather than physical objects.

Where it matters (exam impact): You'll see IP in questions about **professional ethics and legal responsibilities**. Common scenarios involve deciding what kind of protection applies (e.g. patent vs. trade secret) or recognizing when using someone else's idea is a violation. Knowing these categories helps you choose the right course of action on the FE Mechanical Exam and in real engineering practice.

Pitfall: Don't assume an idea is protected just because you came up with it. **An idea alone has no automatic protection** until you take the proper steps (e.g. file a patent or keep it confidential). Also, avoid confusing the categories— for example, **patents** protect inventions, not logos; **trademarks** protect names/logos, not the technical function of a product.

Micro-check: *True/False:* If you design a new machine and tell no one how it works, it's protected as intellectual property by default. (Think about it: is secrecy alone enough, or do you need to take specific steps to secure your rights?)

Exam Handbook Search Cues (Not affiliated with or endorsed by NCEES): intellectual property; patents; trademarks; copyrights; trade secrets

[^1]: **Intangible vs. tangible:** Unlike a physical object (which is tangible property), intellectual property doesn't have a physical form—its value lies in ideas, knowledge, or expression. But once legally protected, it gives you rights just as real as owning a piece of equipment.

K03.T03.S02 – Patents, Trademarks, and Copyright: Protections & Basics

- **Patents** protect **inventions**. If you invent a new and useful machine, process, or material, a patent gives you the exclusive right to make, use, or sell that invention for a limited time. In the U.S., a utility patent lasts roughly **20 years** from the application date. To get a patent, the invention must meet criteria: it must be **novel** (new), **useful**, and **non-obvious** (not an obvious variation of existing ideas). Filing a patent involves a detailed disclosure of how the invention works, and approval by the **U.S. Patent & Trademark Office (USPTO)**. Patents are crucial in engineering because they protect technical innovations – for example, a new pump design or a manufacturing technique [^2].
- **Trademarks** protect **brands and identifiers**. A trademark can be a name, logo, slogan, or other symbol that distinguishes the source of goods or services. For instance, a company's product name or its logo on a machine can be trademarked. The purpose is to prevent consumer confusion – *no one else can use a confusingly similar name or logo on similar products*. Trademark rights in the U.S. come from use in commerce and can be strengthened by registering with the USPTO. A key point: a trademark **does not stop others from making the same product**; it only stops them from branding it in a way that confuses customers. Trademarks can last indefinitely as long as the owner continues to use the mark and defends it (renewing the registration periodically) [^3]. Engineers might encounter trademarks when naming products or working for companies with well-known brands (you must avoid infringing on others' marks).
- **Copyright** protects **original creative works** of authorship. In an engineering context, this can include things like technical drawings, software code, reports, or manuals that *you or your company create*. Copyright

arises automatically the moment an original work is fixed in a tangible form (e.g. when you write a document or create a CAD drawing, you **own the copyright** by default). It gives the owner exclusive rights to reproduce the work, distribute it, make adaptations (derivative works), and display or perform it publicly. Copyrights last a long time – typically for an individual author's lifetime plus about **70 years**. (For works made by a company, it's on the order of 95 years from publication [^4].) Importantly, **copyright protects the expression of an idea, not the idea itself**. For example, a specific CAD drawing of a mechanism is copyrighted, but the mechanical concept it depicts might need a patent for true protection. In the FE exam, you might be asked something like: "Which form of IP protects an engineer's technical report?" (Answer: copyright, since it's a written work).

Table: Comparison of Patent, Trademark, and Copyright
Key differences in what they protect, how to secure them, and how long they last.

IP Category	Protects	How to Obtain	Duration
Patent (invention)	New and useful inventions (products, processes, machines)	File a patent application with full technical disclosure; must be novel and non-obvious (examined by USPTO)	~20 years from filing (for a utility patent)
Trademark (brand)	Distinctive names, logos, symbols that identify a product or company	Acquire by use in commerce (common law rights) and **register** with USPTO for nationwide protection	Indefinite – no expiration as long as it's in use and renewed (typically every 10 years)
Copyright (authorship)	Original creative works (text, drawings, software, graphics, etc.) in tangible form	Automatic upon creation (no application needed, though registration helps in enforcement)	Author's life + ~70 years (for individual works; extended terms for corporate works)

Exam Handbook Search Cues (Not affiliated with or endorsed by NCEES): patents; trademark; copyright law; invention; brand; authorship

Common Exam Pitfalls:

- **Mixing up IP types:** Don't say "trademark" when the scenario is about an invention, or "patent" when it's about a logo. Identify *what is being protected* – invention ⇒ patent, brand name ⇒ trademark, written/drawn content ⇒ copyright.

- **Assuming broad protection:** A **U.S. patent protects only within the United States**[^5]. If an exam question hints at international considerations, remember that patents (and trademarks) are territorial – separate filings are needed elsewhere.

- **Trademark limits:** Trademark protection stops confusing branding, *not* the existence of a competing product. For example, you can't trademark the concept of a wrench – you can only trademark your unique brand name or logo for your wrench.

Another company can make a similar tool under a different brand.
- **Ideas vs. expression:** Simply having an idea doesn't guarantee protection. Patents require detailed **public disclosure** (you trade secrecy for legal protection), and copyrights only cover the specific expression (e.g. the text of a report, not the engineering idea described in it). If an engineer sketches an idea in a notebook and publishes it openly before patenting, they might lose the chance to patent it later [^6].

Explanation & Analysis: As an engineer, knowing these formal IP protections guides you in safeguarding your work and **avoiding infringement**. Here's how to use each:

- **Patent in practice:** Use a patent when you invent something truly new and useful that isn't obvious. For example, suppose you develop a more efficient heat exchanger design. To protect it, you'd document how it works and file a patent application. Once granted, you (or your company) can stop others from making or selling that heat exchanger in your country for 20 years. The catch is you must disclose the details in the patent, which becomes public information. On exam day, if you see a question about an **exclusive right to a mechanical design**, think patent. Recognize keywords like *"invention," "new device," "USPTO application,"* etc., as cues that the patent concept is being tested.
- **Trademark in practice:** Use trademarks to protect the identity of a product or service. If your company creates a new product called "ThermoFlow," you'd trademark that name (and maybe a logo) so no one else in the same industry can brand their product similarly and confuse customers. Trademarks often appear in exam questions that discuss company names or logos – e.g., *"What type of IP covers a company's unique logo on a machine?"* The answer is trademark. A common mistake is thinking a trademark protects the technology – it doesn't. It's purely about **identifiers** in commerce.
- **Copyright in practice:** Rely on copyright for things like engineering drawings, software code, and documentation. If you write a simulation program or draft an engineering report, copyright law automatically gives you the right to control copying and distribution of that work. In an exam scenario, if the question involves an engineer's *writings or figures*, consider copyright. Keep in mind that copyright doesn't stop someone from independently creating a similar document or design from scratch – it just prevents *literal copying* of your specific work. And it certainly won't protect an underlying invention's functionality (that's a patent's job).

By understanding patents, trademarks, and copyrights, you can answer questions about which protection is appropriate or what rights each one grants. Always match the **type of creation** to the

type of IP: is it a product or process (patent), a name/logo (trademark), or a creative work (copyright)?

[^2]: **Types of patents:** There are multiple patent types. The most common for engineers is the *utility patent* (for new processes, machines, materials, etc.). The U.S. also grants *design patents* for new ornamental designs of manufactured items (these last 15 years from issuance, shorter than utility patents), and *plant patents* for new varieties of asexually reproduced plants.

[^3]: **Trademark longevity:** A trademark can last *forever* in theory, but the owner must continue using it in trade and periodically file renewals (in the U.S., renew at 10-year intervals, with a proof of use). If a trademark isn't used or the owner doesn't renew/defend it, it can be lost (or even become generic, like "aspirin" did).

[^4]: **Corporate works:** For works made for hire or corporate authorship, U.S. copyright duration is typically about 95 years from its publication (or 120 years from its creation, whichever comes first). For exam purposes, it's enough to know copyright lasts many decades – far longer than patents.

[^5]: **Territorial rights:** IP rights are generally national. A U.S. patent gives rights in U.S. territories only. Likewise, a U.S. trademark covers the U.S. If you see a scenario about an international product, consider that separate patents/trademarks would be needed abroad.

[^6]: **Public disclosure caution:** If you publicly disclose an invention (say, publish a paper or put it online) *before* filing a patent, most countries will bar you from patenting it later (the idea is now public domain). The U.S. has a limited one-year grace period, but it's risky.

Exam tip: If a question describes an engineer eager to share or publish a new design, ask yourself: have they secured a patent first, or are they inadvertently giving up their rights?

K03.T03.S03 – Confidentiality and Trade Secrets in Engineering Projects

- **Trade secrets** protect **secret information** that gives a business advantage. Unlike patents, **trade secrets are not registered** with the government. Instead, they rely on **confidentiality**. Common examples: formulas, recipes, manufacturing processes, proprietary algorithms, or even client lists. If this information is kept secret and is valuable because it's secret, it qualifies as a trade secret. A famous example is the formula for a soft drink [^7]. In engineering, you might develop a process or know-how that your company chooses *not* to patent (perhaps to avoid revealing it publicly); instead, they treat it as a trade secret and expect you to keep it under wraps.
- **Confidentiality** is an ethical and legal duty. Engineers are often required to sign **Non-Disclosure Agreements (NDAs)** when working on projects, which are contracts promising not to reveal certain information. Even without a signed NDA, professional codes of ethics state that engineers **must not disclose confidential information** about their employers' or clients' work without permission. On the FE Exam, you might see a scenario like: *"Engineer A is leaving Company X for Company Y. At Company X, A worked on a confidential project with an unpatented process. What can A do with that knowledge at the new job?"* The expected answer: A **cannot use or reveal** Company X's proprietary process at Company Y – it's protected as a trade secret and sharing it would be unethical (and likely illegal).
- **Key difference from patents:** A trade secret can last **indefinitely** as long as it stays secret. There's no 20-year limit – the protection ends only when the secret gets out. However, there's a trade-off: if someone *else* discovers the same technique independently or through reverse engineering, your trade secret offers no exclusionary rights. In contrast, a patent would have prevented independent inventors from using the invention without permission. Companies often must choose: patent vs. trade secret. *If the knowledge can be kept in-house (and is hard to guess), a trade secret avoids public disclosure; but if others could easily figure it out, a patent might be safer.*
- **Engineer's responsibility:** Maintaining confidentiality means handling documents carefully (marking them confidential, restricting access) and not discussing sensitive details outside authorized circles. If you're working on a project, assume that technical and business details are private to your team/company unless told otherwise. This extends beyond employment: even after you leave a job, trade secret information you learned there **stays off-limits** in your conversations or new work, **until it becomes public** legitimately. Violating confidentiality can lead to lawsuits (under trade secret law) and will certainly violate the FE exam's ethics expectations. On exam day, if a question asks what to do with information labeled "proprietary" or "confidential," the answer is always: **do not share it without approval**.

Definition: *Trade secret* – Any **information** (formula, process, design, method, etc.) that derives economic value from not being generally known and is subject to **efforts to keep it secret**. In simpler terms, it's the **"secret sauce"** that gives a company an edge. If you keep it secret, it can make money; the moment it's out, that exclusive value is lost.

Where it matters (exam impact): Trade secrets and confidentiality show up in ethics questions, especially scenarios involving NDAs, former employers, or client data. You might be asked what is considered a trade secret, or what an engineer should do when possessing sensitive info. Knowing this concept helps you pick the choice that involves **protecting confidentiality**.

Pitfall: Believing that calling something a "trade secret" is enough, you **must actively keep it secret**. That means companies should use NDAs, password protections, etc., and engineers must be diligent. If secret information is accidentally leaked or not well-guarded, it can lose its trade secret status [^8]. Another common mistake is thinking you can ignore an NDA because you personally developed the tech. **Wrong!** Even if you invented it at Company X, if you agreed (or are expected by ethics) to keep it confidential, you can't take it to Company Y.

Micro-check: *True/False:* An engineer publishes an article detailing a proprietary machine design from their workplace, without permission. Since the design was unpatented, this is okay because no formal IP was violated. (Consider the trade secret implications and ethical duties before you answer.)

Exam Handbook Search Cues (Not affiliated with or endorsed by NCEES): trade secret; confidentiality; proprietary; nondisclosure; NDA; secret information

Common Exam Pitfalls:

- **Breaking confidentiality:** In scenario questions, any hint that an engineer is sharing client/employer information (data, designs, etc.) without consent should raise a red flag. The correct action is usually to *decline to disclose* or to *get permission*. Don't be tricked by answer choices that justify leaking info for "the greater good" or personal gain – on the exam (and real life ethics), protecting confidential information is paramount (unless there's an overriding public safety concern).

- **Forgetting legal context:** Remember that an NDA is a legal document. If you sign one, you're legally bound *and* ethically bound. Even if no explicit NDA, using a previous employer's secret design at a new job can still violate trade secret law. The exam may expect you to know that trade secret theft is illegal, not just "unprofessional."

- **Patent vs. Trade Secret confusion:** If a process is patented, it's *not* a secret – it's published. So you wouldn't call a published formula a trade secret. Conversely, if something is a trade secret, it means it hasn't been patented (or else the cat's out of the bag). An exam question might test this: e.g., "Company has a special process not known to competitors – what IP protection applies?" The best answer: trade secret (assuming they haven't patented it).

- **Disclosing before patenting:** If you plan to patent an invention, **do not disclose it publicly too early**. Share internally on a need-to-know basis and perhaps have others sign NDAs. On the exam, a story of an engineer wanting to publish a paper on a new device before filing a patent is a cautionary tale – the correct advice would be to patent first or risk losing patent rights.

Explanation & Analysis: In day-to-day engineering projects, confidentiality is like the silent handshake of trust. Companies invest in R&D and expect their engineers to keep certain details in-house. Here's how you handle trade secrets on the exam and in real life:

- **Recognizing a Trade Secret scenario:** Keywords to watch for include "proprietary," "confidential," "secret formula," "internal process," or mention of an NDA. These signal that the question is about trade secrets. For example, "Engineer B is given a confidential blueprint from a client to complete a project…" – you should immediately think about your duty to protect that blueprint's information. The question might ask what actions are appropriate (answer: secure the information, use it only for the project, do not share with unauthorized parties).
- **Your actions as an engineer:** If an exam question asks what you should do in a situation involving a trade secret, the safe answers involve **maintaining secrecy**: e.g., store documents securely, discuss only with cleared team members, and refuse requests to reveal details externally. If the scenario involves leaving a company, the right action is to return or destroy confidential materials and not use them elsewhere. Ethically, engineers must keep confidential information from their work private unless they have proper authorization or are required by law to disclose it. Expect the exam to align with that principle.
- **Legal protections in play:** While patents give you a legal monopoly for a time, trade secrets rely on contract law and state/national trade secret laws for protection. If someone misappropriates a trade secret (say, hacks into a company to get a formula, or an ex-employee breaches an NDA), legal action can be taken under laws like the Uniform Trade Secrets Act or Defend Trade Secrets Act. You don't need to memorize those laws for the FE, but understand that **stealing or leaking trade secrets is illegal**. Conversely, if a competitor figures out your secret fairly (independent discovery or reverse-engineering a publicly available product), that's legally allowed – which is why trade secrets are a bit **fragile** as a form of IP.
- **When to choose trade secret vs. patent:** This could be relevant in a conceptual question. Patents require revealing the invention and eventually expire, but in return you get strong protection (no one can use that invention without your permission, even if they came up with it separately). Trade secrets require perpetual secrecy; they never expire, but offer no protection if the secret gets out. A company might keep a process secret if it's hard for others to figure out (so the risk of independent discovery is low). But if it's something others could easily reverse-engineer from your product, better to patent it. In an exam context, you might be asked something indirectly about this trade-off—recognize the clues. For instance, *"Why might a manufacturer choose not to patent a special heat treatment process?"* Likely answer: to avoid disclosing it and instead keep it as a trade secret, especially if it's hard to deduce from the final product.

By mastering confidentiality and trade secret practices, you'll not only be prepared for related FE questions but also be ingrained with habits that protect you in your engineering career. Remember: **when in doubt, don't spill the secrets!**

[^7]: The formula for Coca-Cola is a classic example of a trade secret. It has been kept confidential for over a century, showing that trade secrets can effectively last much longer than patents as long as they remain secret.

[^8]: **Maintaining secrecy:** Courts will only uphold trade secret status if the owner actually took reasonable measures to keep the information secret. For engineers, this means you'll see things like locked project labs, encrypted files, and NDAs. If a company is careless (e.g., publishes details on a public website by mistake), the "secret" might be deemed lost. Always handle proprietary data with care – on the exam, choose the answer that reflects safeguarding information (e.g. "mark the document confidential and limit access" is a good action to pick).

Topic 04 - Societal Considerations

Topic Intro: **Societal considerations** in engineering refer to the broad obligations engineers have toward the environment, public welfare, and long-term sustainability of their designs. On the **FE Mechanical Exam**, questions on this topic are typically conceptual. You might be asked to identify which design choice is more sustainable, which factors a **life-cycle analysis** should include, or how an engineering decision impacts society at large. Mastering this topic means understanding the **"big picture"** impact of engineering work – beyond just technical performance – including environmental stewardship, public safety, and economic responsibility. These questions often appear as ethical scenarios or design rationale queries, not heavy calculations. But they are just as critical: they test whether you, as an engineer in training, recognize your professional duty to create solutions that are **safe, sustainable, and socially responsible**.

K03.T04.S01 – Principles of Sustainable Development in Engineering Design

Principle Introduction: Sustainable development in engineering design is all about **meeting today's needs without compromising tomorrow's needs**. Key principles include:

- **Intergenerational Responsibility:** Design solutions should meet present requirements **without** robbing future generations of resources or opportunities. This means using resources wisely and planning for long-term impacts.
- **Triple Bottom Line (Three Pillars):** True sustainability balances **environmental**, **social**, and **economic** factors. A project must be **environmentally sound**, **socially beneficial**, and **economically feasible** to be considered sustainable.
- **Holistic Design Mindset:** Engineers incorporate sustainability by considering the **full scope of a project's impact** – from material sourcing and energy use to public safety and community welfare. This goes beyond compliance; it's a proactive effort to minimize harm and maximize benefits for society.
- **Preventive Action:** Emphasizes designing **out** potential problems (pollution, hazards, waste) at the start rather than fixing them later. For example, choosing non-toxic materials and energy-efficient processes upfront to avoid environmental damage down the line.
- **Resource Stewardship:** Prioritize renewable resources and efficient use of materials. **Non-renewable resources** (like fossil fuels, rare metals) should be conserved, and alternatives sought when possible. This also includes recycling and reusing materials to extend their life cycle.

Exam Handbook Search Cues (Not affiliated with or endorsed by NCEES): *sustainable, sustainability, sustainable design, resource allocation, non-renewable*

Footnotes: Sustainability in engineering is often traced back to the **Brundtland Commission (1987)**, which framed the famous definition of sustainable development (paraphrased above) – it's about long-term thinking and fairness to future generations. Keep in mind that **"sustainable" != "just green"** – it's not only about the environment; safety, health, and finances count too. Engineers sometimes use terms like *"green design"* or *"eco-friendly design"*, but those usually focus only on environmental aspects; **sustainable design** is broader, covering social and economic impacts as well.

Variations & Related Concepts: Some related ideas include **inherently safe design** (designing systems to be fail-safe and minimize hazards – overlaps with sustainability through safety) and **resilient design** (ensuring structures or systems can withstand and recover from unexpected events, complementing sustainability's long-term view). Also, keep in mind regulatory frameworks (like building codes, environmental regulations) often embed sustainable practices – so following the law is usually the minimum; true sustainability often goes further.

Explanation & Analysis: Sustainable development principles guide engineers to **think beyond immediate project boundaries**. On the FE Exam, you might see a question like:

"Which of the following design choices best aligns with sustainable engineering practices?" To answer, recall that a sustainable choice is one that *minimizes negative impacts and maximizes long-term benefits across environmental, social, and economic dimensions*.

Let's break down those dimensions:

- **Environmental:** Does the solution reduce pollution, conserve energy and water, protect ecosystems? For example, using a high-efficiency HVAC system might cost more initially but will cut energy use (environmental benefit) and save money over time (economic benefit).
- **Social:** Does it protect public **health and safety**, and enhance quality of life? For instance, designing a machine with proper guards and low noise output safeguards workers (safety) and neighbors (community well-being). In sustainable design, *public welfare is paramount* – this is codified in engineering ethics as the duty to hold public safety above all else.
- **Economic:** Is the project financially viable and beneficial? A sustainable project should be cost-effective over its life cycle (not just cheap upfront). Often this is assessed via life-cycle cost, but conceptually it means a project that can economically sustain itself and perhaps provide jobs or other economic gains to the community.

These aspects are often visualized as the **three pillars** or **triple bottom line** (more on that soon). A design that excels in one facet but fails in another is **not fully sustainable**. For example, a factory that is highly profitable and provides jobs (economic + social positives) but dumps toxic waste into a river (environmental negative) is *not* a sustainable solution – eventually the environmental damage will hurt society and even the economy (think cleanup costs, health care costs, lost fisheries, etc.). Conversely, an eco-friendly technology that is so expensive no one can afford it also isn't sustainable, because it won't be adopted in practice. The goal is to **achieve balance**: engineers often perform trade-off analysis to tweak designs until they hit an acceptable sweet spot of environment, society, and economy.

In practice, applying sustainable development means **asking the right questions at each design step**. Are there greener material alternatives? Can we reduce energy consumption? How will this choice affect the public's safety or quality of life? By consistently

posing such questions, you build sustainability into the project from day one. A common pitfall on the exam (and in real life) is to equate "sustainable" with just *one* thing (like only carbon footprint or only cost). Always remember the broad view – multiple lenses.

Finally, note that sustainable design isn't just an ethical nice-to-have; it often leads to **innovative engineering solutions**. Constraints like limited resources or strict emissions targets can spark creativity – think of how the push for sustainability has led to advances in renewable energy, recycling technologies, and high-efficiency systems. So, for exam day, be prepared to identify sustainability principles in action. It could be as straightforward as recognizing that *recycling materials, designing for energy efficiency, planning for safe end-of-life disposal, or safeguarding user safety* are all manifestations of sustainable engineering practice.

K03.T04.S02 – Environmental & Social Impact Considerations (Life-Cycle Analysis)

Principle Introduction: A **Life-Cycle Analysis (LCA)** is a systematic approach to assess **all the environmental impacts** of a product or project **from cradle to grave**. Instead of looking at just one snapshot (like emissions during operation), LCA tracks the **entire journey**:

- **Cradle-to-Grave Scope:** LCA considers every phase – from raw material extraction and processing, through manufacturing and construction, distribution, the product's use/operation, and finally its end-of-life (disposal or recycling). "Cradle" is the start (materials coming from the earth), and "grave" is the end (materials returning to earth or otherwise disposed).
- **Comprehensive Impact Accounting:** At each phase, LCA tallies up all relevant impacts: energy consumption, raw material depletion, waste generation, emissions to air (e.g. greenhouse gases, pollutants), discharges to water (water pollution), land disturbances, etc. This gives a **complete environmental footprint** of the product/project.
- **Hotspot Identification:** By evaluating all stages, LCA helps identify where the biggest impacts occur (the "hotspots"). Perhaps manufacturing a component produces more CO_2 than its entire usage phase, or maybe disposal creates toxic waste – LCA will reveal that. This guides engineers to focus mitigation efforts on the most impactful stages.
- **Design Decision Tool:** Engineers use LCA to compare design alternatives or improvements. For example, is an electric vehicle really greener than a gasoline car when manufacturing and electricity generation are accounted for? LCA provides the framework to answer such questions quantitatively.
- **Includes Social/Economic Factors?** Traditional LCA mainly focuses on environmental factors, but **broader impact assessments** can include social impacts too. In project planning, you might see **Environmental Impact Assessments (EIA)** or **Environmental and Social Impact Assessments (ESIA)** which qualitatively consider effects on local communities (like relocation, cultural heritage, job creation) alongside the environmental LCA. On the FE exam, however, the emphasis will be on understanding the environmental *life-cycle* concept, with the expectation that you recognize the need to consider social impacts similarly in a holistic project review.

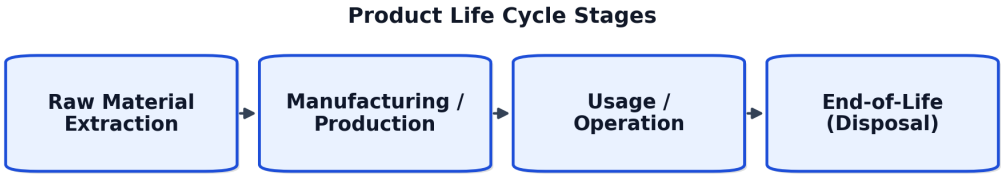

Stages of a cradle-to-grave life-cycle for a product. The life-cycle analysis ensures each stage – from obtaining raw materials to manufacturing, to usage, and finally disposal – is examined for environmental impact. Engineers trace energy use, emissions, and waste at every step, building a complete picture of a project's footprint. The goal is to catch hidden impacts that single-stage analyses would miss (e.g. a product that is efficient in use but very polluting to produce). By addressing each stage, LCA supports more sustainable overall design choices.

Exam Handbook Search Cues (Not affiliated with or endorsed by NCEES): *life-cycle analysis, cradle to grave, environmental consequences, emissions, waste*

Footnotes:

Don't confuse **Life-Cycle Analysis (LCA)** with **Life-Cycle Cost Analysis (LCCA)** [^1]. LCCA is about dollars – calculating total cost of ownership (investment, maintenance, operating cost, disposal cost). It's an Engineering Economics topic. **LCA, on the other hand, is about environmental impact.** The exam might mention "life-cycle analysis" in the context of sustainability – that's the environmental one. Remember, *cradle-to-grave = environmental*, while *cost over life = economic*. Both are important, but in different knowledge areas of the exam.

[^1]: Life-Cycle Cost Analysis (LCCA) evaluates the total financial cost of a project over its lifespan. It's a separate concept often used in Engineering Economics. For example, choosing between two machine designs might involve an LCCA to see which is cheaper in the long run. But an LCA would compare which machine is greener over its life.

Variations & Related Forms:

Sometimes you'll hear **"cradle-to-cradle"** instead of cradle-to-grave. Cradle-to-cradle is a sustainability ideal where the "end-of-life" of a product feeds into a new life (like recycling or reusing so nothing truly becomes waste – the "grave" is eliminated). While not explicitly tested, it underscores the goal of designing products that can be **recovered and reused** ad infinitum (a circular economy concept). Also, engineers might do a **carbon footprint analysis** as a subset of LCA – focusing specifically on greenhouse gas

emissions of a product's life cycle (measured in CO_2-equivalent). In a broader sense, **Environmental Impact Assessment (EIA)** is a formal process (often legally required for big projects) that examines potential impacts on the environment and sometimes on society; it's less formulaic than LCA, but aligned in spirit (it might include LCA-type data).

Special Notes:

If a calculation is involved, it's usually simple proportional reasoning (like "Stage X accounts for 40% of the total CO_2 emissions of a product. If total emissions are Y, how much is from Stage X?"). You won't be asked to perform a full LCA with complex software on the exam – it's about concepts and recognizing scope. Also, any formulaic expression in LCA would just be summing up impacts: e.g. $$\text{Total Impact} = \sum_{\text{stages}} \text{Impact}_i,$$ which is straightforward summation. There's no single fancy equation to memorize for LCA – focus on **the stages and what to consider at each stage**.

Explanation & Analysis:

Let's walk through an example to see LCA thinking in action. Imagine a question: *"An engineer is comparing two materials for a machine component: one is aluminum, the other is a composite. The aluminum part requires a lot of electricity to produce but makes the machine slightly more energy-efficient during use. The composite part is easy to manufacture but makes the machine heavier, increasing fuel use. What should the engineer consider according to life-cycle analysis?"*

Using LCA principles, the engineer should consider **both production and usage phases**:

- **Material Production Phase:** Aluminum production is energy-intensive (and often uses electricity from fossil fuels, leading to CO_2 emissions). The composite might be less energy to produce, but perhaps its raw materials are petroleum-based and produce chemical waste. We'd quantify emissions, waste, energy for each material's production.
- **Usage Phase:** The aluminum part is lighter, so the machine uses less fuel/electricity over its life – that's a big environmental saving during operation. The composite part, being heavier, means more fuel burn or energy to operate the machine for years – leading to higher emissions in the usage phase.
- **Other Phases:** What about end-of-life? Aluminum is highly recyclable – at end-of-life, that aluminum can be melted down and reused (saving future production energy). Some composites are not recyclable and might go to landfill. Also consider if either material has maintenance impacts (corrosion of aluminum vs durability of composite).
- **Transportation:** If relevant, include transport of materials or the fact that a heavier machine requires more transport energy when being delivered.

By summing up these factors, LCA might reveal, for instance, that *even though aluminum has a higher production impact, the long-term savings in fuel make it the greener choice overall* (or vice versa, depending on numbers). The exam won't have you do all that math, but they expect you to grasp that **different stages trade off**. The "greener" option isn't obvious until you consider **the full life cycle**.

A common **trap** is to focus only on the usage phase (operational efficiency) and ignore manufacturing and disposal. The FE question might be conceptual like, "Which factor is **not** typically considered in a life-cycle analysis?" with a choice like "initial project cost" (which is economic, not environmental, hence not in an environmental LCA) – a clue that they want you to distinguish between LCA vs cost analysis. Or they might ask which stage of a given product's life has the **highest impact**: for example, many electronics have most of their environmental impact in manufacturing (mining and chip fabrication are energy intensive and produce waste), whereas a car might have more impact during use (burning fuel for years). Knowing these typical patterns can help eliminate wrong answers.

Finally, **social impact considerations** parallel LCA: when planning a large project (like a new highway or factory), engineers perform studies to assess social impacts – e.g., will any communities be displaced? How will traffic noise affect neighborhoods? Are there equity concerns (disproportionate impact on a disadvantaged group)? These aren't part of a numeric LCA, but ethically and often legally, they must be weighed. For the exam, just remember that a **sustainable solution looks at both environmental and social ramifications**. So if asked, "What should engineers be concerned about when implementing a new chemical plant in a town?" you'd answer not only environmental emissions (air, water quality) but also social facets (jobs, safety of residents, emergency planning, etc.).

In summary, use **Life-Cycle Analysis** thinking to ensure no facet of a project's impact is overlooked. It's a mindset: **zoom out and see the whole picture**, then zoom in on the hotspots to mitigate them. If you see the phrase "cradle-to-grave" on exam day, it should trigger: "Consider *all* stages of the life of whatever is being discussed." That's the essence of this subtopic.

K03.T04.S03 – Broader Social Implications of Engineering Solutions (Global, Economic, Environmental Facets)

Principle Introduction: Engineering doesn't happen in a vacuum – every solution has a ripple effect on society. This subtopic zooms out to the **big-picture implications** of our engineering decisions, often framed by the **triple bottom line** concept:

- **Triple Bottom Line (People, Planet, Profit):** Engineers evaluate success not just by technical metrics, but by **three facets** – **Social** (*People*), **Environmental** (*Planet*), and **Economic** (*Profit*). This ensures a **balanced outcome**: does it improve lives, is it eco-friendly, and is it economically sound? The triple bottom line is essentially the core of sustainability, highlighting that a project must be good for society and the environment *while* being financially viable.
- **Global Perspective:** Modern engineering solutions can have **global impacts**. For example, greenhouse gas emissions from one country affect the global climate, or using rare minerals for electronics ties into global supply chains and economies. Engineers must recognize such global interconnections. A decision in design (like choosing a material sourced from across the world) has economic implications (cost, trade) and possibly ethical ones (are those materials mined sustainably? any human rights issues?).
- **Long-Term & Systemic Thinking:** Broader implications often appear in the long term. An engineering project might solve an immediate problem but create future ones if not carefully planned. For instance, widespread

adoption of a certain technology could deplete natural resources or disrupt job markets. This principle pushes engineers to think **systemically** – if we deploy this solution at scale, what happens in 10, 20, 50 years? Will it still be beneficial?

- **Public Welfare and Equity:** Social implications include how engineering projects affect communities. Does the solution serve the **public good**? Does it **protect public safety** and improve quality of life? And equally important, are the benefits and burdens distributed fairly (environmental justice)? For example, building infrastructure in a city should consider not just economic growth but also whether it might disproportionately impact a poorer neighborhood with pollution or displacement. Engineers have a duty to guard **public welfare**, per the fundamental canons of ethics.
- **Economic Context:** Any engineering solution sits within an economic context – locally and globally. A project could boost the economy by creating jobs and innovation, or it could have negative economic effects (like making a region dependent on a resource that might run out). Sustainable solutions try to ensure *economic resilience*: that communities can maintain prosperity without boom-bust cycles or crippling future costs (like cleanup costs for environmental damage).

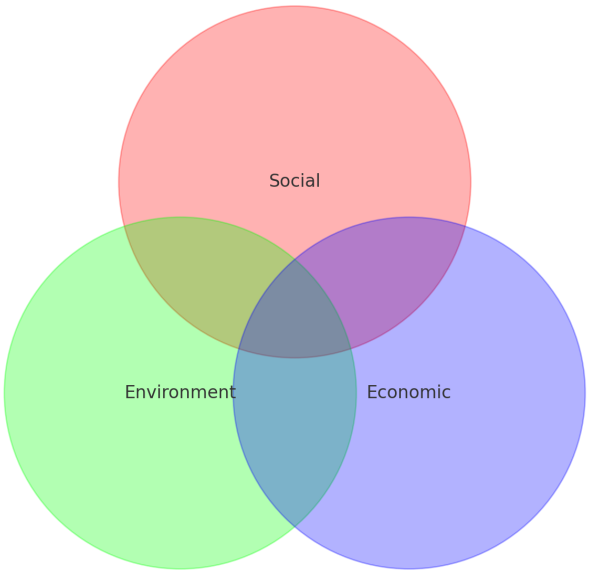

The Triple Bottom Line Venn diagram illustrates the overlapping domains of Social (People), Environmental (Planet), and Economic (Profit) considerations. An engineering solution that hits the sweet spot in the center – satisfying all three realms – is the ideal outcome for sustainability. For example, a project that creates jobs and benefits the community (Social), preserves or enhances the environment (Environmental), and is financially successful (Economic) achieves this balance. The overlaps show that these domains are interconnected: environmental and social responsibility can go hand-in-hand (e.g. reducing pollution also improves public health), social and economic goals can align (e.g. fair labor practices can improve productivity), and economic and environmental interests can converge (e.g. energy efficiency saves money and cuts emissions). Engineers use the triple bottom line as a guiding framework to ensure no critical facet is ignored when assessing a project's true impact.

Exam Handbook Search Cues (Not affiliated with or endorsed by NCEES): *triple bottom line, people–planet–profit, societal impact, global impact, sustainability*

Footnotes: The phrase **"triple bottom line"** is sometimes abbreviated as **TBL** or called the **3Ps** (for People, Planet, Profit). It's not an equation, but rather a **framework for thinking**. Don't worry about math here – it's about categories of impact. Another term you might hear is **"Corporate Social Responsibility (CSR)"**, which is a related concept in industry – companies voluntarily ensuring their operations are ethical and sustainable (covering similar social, environmental, economic grounds). While CSR itself isn't likely a test topic, it reflects the broader expectation that engineers in companies consider their impact on society.

Variations & Adjacent Topics: This area blends into ethics: the **NSPE Code of Ethics** and similar codes stress obligations to society, public welfare, and sustainability. In some questions, societal considerations might overlap with **public health and safety** questions or **engineering economics** questions. For example, a question might give an economic scenario but ask about externalities (costs or benefits to society not captured in the market price, like pollution costs – which is a societal consideration bridging economics and ethics). Also, think about **risk-benefit analysis** in societal terms: e.g., introducing a new technology (like autonomous vehicles) brings benefits (efficiency, fewer accidents maybe) but also new risks (cybersecurity, job displacement for drivers). Engineers must weigh these for responsible innovation.

Explanation & Analysis: To analyze the broad social implications of an engineering solution, it helps to explicitly break it down by the triple bottom line on exam questions:

- **Social (People):** Ask, "Who are the stakeholders and how are they affected?" Stakeholders include not just the client or end-user, but the public, workers, community, and even future generations. For instance, if you build a dam, stakeholders are: people who get electricity and water (benefit), people who might be displaced by the reservoir (harm), fishermen downstream who see changes in river flow (could be harm or benefit), etc. Social implications might cover health (does it improve or harm health?), safety (any new dangers introduced?), quality of life (noise, traffic, aesthetics?), and equity (are benefits shared fairly, or do only some people benefit while others suffer?). In exam terms, an answer choice that highlights an effect on **public safety, community well-being, or ethical obligation to the public** is touching the social leg of the tripod.
- **Environmental (Planet):** Think in terms of **natural capital** – resources and ecosystem services. Does the project consume a lot of energy? Does it emit pollutants or greenhouse gases? Are there impacts on land (deforestation, habitat destruction), water (usage or contamination), or air? A global environmental lens also considers things like climate change: e.g., a design that relies on a high carbon footprint process has global climate implications. If an exam question scenario mentions anything about emissions, waste, or regulations like EPA standards, you're in the environmental realm of societal impact.
- **Economic (Profit):** This isn't just the profit for one company – it's the **economic impact on society or stakeholders**. For example, a new technology could reduce costs for consumers (positive economic impact), or a project might create jobs (boost local economy).

Conversely, it could have costs like necessitating tax hikes or causing another industry to decline. Engineers should consider long-term economic sustainability: will operating costs or maintenance be burdensome to future generations? On the exam, if a choice talks about **cost-benefit to society**, **job creation**, or **long-term economic viability**, it's addressing this facet.

Global implications often tie these together: consider climate change (environmental global issue), which in turn affects societies worldwide (social) and requires international economic cooperation (economic). Or consider the spread of engineering innovation globally – positive example: spread of renewable energy tech creates global environmental benefit, knowledge sharing (social benefit), and economic opportunities in new markets. Negative example: exporting a hazardous waste to another country might spare the local environment but harm another (ethical issue). The FE won't ask about specific global policies, but a savvy engineer recognizes that engineering decisions have **cross-border effects** and ethical dimensions.

A **typical FE question** in this area might be a short scenario: *"An engineering firm is deciding between two project proposals: Project A yields high immediate profits but could result in significant long-term environmental cleanup costs. Project B is less profitable upfront but has negligible environmental impact and provides more community jobs. Considering societal implications, which project is more aligned with sustainable professional practice?"* The expected answer would be Project B, because it balances profit with environmental protection and social benefits (jobs), whereas Project A externalizes a cost to society (future cleanup and likely environmental harm). This kind of question tests whether you apply **ethical reasoning** and **sustainability principles** rather than just chasing short-term gain.

Common Exam Traps: One trap is thinking that *any* economically beneficial project is automatically good for society. The exam may include a choice that emphasizes cost savings or profit but ignores environmental or safety consequences – be wary of that. Another trap is the opposite: focusing only on the ideal environmental solution without regard for feasibility. A choice might sound super "green" but if it's economically implausible (like requiring unlimited budget or nonexistent tech), it's not the best answer in context. Look for answers that reflect **balance**. Also, remember that **public safety is part of societal impact** – so even if a question is under this topic, the correct answer might talk about safety or health. That still counts, because protecting people is perhaps the most direct social responsibility of engineers.

In essence, **broader social implications** = *think like a responsible professional*. The FE Mechanical Exam is gauging if you as an engineer will be able to see beyond the immediate problem and consider how your work interacts with the world. This is why it's in the Ethics and Professional Practice section. As a finishing thought, keep this mantra in mind: *Engineering success is not just measured in technical performance, but in human and environmental outcomes.* If you internalize that, you'll be equipped to tackle these questions with the right mindset.

DON'T MOVE ON YET!

Work Through Some Solid Practice Problems
while the Material of this Knowledge Is Still Fresh
THIS IS HOW THE CONCEPTS LOCK IN.

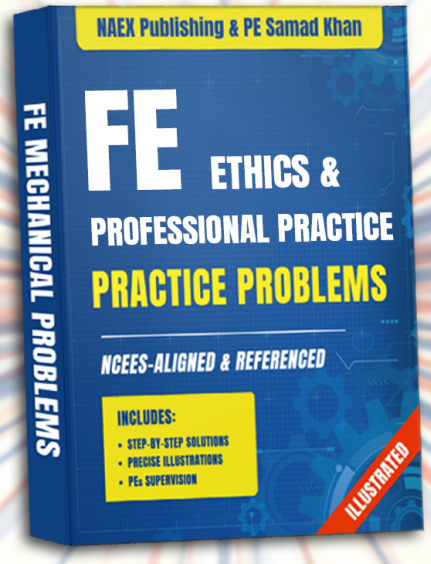

CLICK HERE TO PRACTICE

You'll be taken to our Discord Server,
where the problems are located.

KNOWLEDGE 04

ENGINEERING ECONOMICS

- NAEX Publishing -

"This publication is not affiliated with or endorsed by NCEES".

Topic 01 - Time Value of Money

Topic Intro – What & Why: *The time value of money* is the core principle that a sum of money has a different value depending on when it is received or paid. A dollar today is worth more than a dollar a year from now, because the dollar today can be invested to earn interest. This topic matters on the FE Mechanical Exam because many economic questions boil down to comparing cash flows at different times – for example, finding the present worth of future savings, calculating an equivalent uniform annual cost, or deciding between project alternatives using interest rates. You'll typically encounter question scenarios like *"What is the equivalent present value of $X received in Y years at Z% interest?"* or *"Which project yields a higher net present worth given a certain MARR (minimum attractive rate of return)?"* Mastering time value formulas and factor tables means you can quickly convert money values between time points, ensuring apples-to-apples comparisons on exam day. In short, **time value of money is the "exchange rate" between present and future dollars** – and the exam will test that you know how to use it.

Exam Tip: Before crunching numbers, **sketch a quick timeline** of the cash flows in the problem. Mark what is given (present sum P, annual payment A, future value F, interest rate i, number of periods n) and **identify what equivalent you need to find** (e.g., "find present worth at time 0" or "find annual worth over n years"). This simple step frames the problem and helps you pick the right formula or factor. On exam day, speed is crucial – so set up the problem clearly, then grab the correct time value factor from memory or the exam reference, and compute. Let's break down the key subtopics: present/future/annual equivalences, nominal vs effective interest, MARR and inflation effects, and using the standard interest factor tables.

K04.T01.S01 – Present, Future & Annual Worth (Single Sums & Uniform Series)

Principle Introduction: Time value of money allows *equivalence* between a single sum and another sum at a different time, or between a lump sum and a uniform series of payments:

- A **present worth** P is a single sum at time 0 that is financially equivalent to some future cash flow or series of cash flows when interest is considered.
- A **future worth** F is a sum at a future time n equivalent to a present amount P invested at interest rate i. Conversely, discounting finds P given a future F.
- An **annual worth** A (or *equivalent annual amount*) converts a lump sum into an equivalent uniform series of payments (or vice versa) over n periods. This is useful for comparing options on a yearly cost or benefit basis (often called **capital recovery** when finding A from an initial P).
- **Uniform series** formulas (annuity formulas) handle a series of equal end-of-period amounts. Using these formulas or their tabulated factors, you can collapse multiple cash flows into one P or F, or spread one P into equal A payments.

In summary, single-sum compounding and annuity factor formulas let you convert money between different timeframes **assuming a fixed interest rate** i. Master these conversions and you'll handle most cash-flow equivalence problems with ease.

Equation Passport – Compound Interest (Single Payment): This fundamental formula relates a present lump sum and its future value after n periods at interest rate i. It underpins more complex cash flow conversions.

Name & purpose: *Compound interest formula* – computes the future value F of a present amount P after n compounding periods, or equivalently the present worth P of a future amount F.

Equation: $F = P\,(1+i)^n$. Equivalently, $P = F\,(1+i)^{-n}$ for finding present worth.

Variables & units:

- P = present worth (value at time 0, in currency units).
- F = future worth (value at time n, in the same currency units as P).
- i = interest rate per period (decimal form, e.g. 0.05 for 5%).
- n = number of compounding periods (years, quarters, etc., consistent with the period for i).

Assumptions & scope:

- Interest rate is **constant each period** and compounding occurs at the end of each period (discrete compounding).
- No other deposits or withdrawals occur between the single P at time 0 and F at time n (this is a one-time lump sum growth/discount).
- Valid for any time units (years, months) as long as i and n correspond (e.g. if i is annual, then n is in years).
- Applies to positive or negative cash flows alike (just be consistent with sign convention for outflow vs inflow).
- **Limit tests (sanity checks):** If $n = 0$, then $(1+i)^n = 1$ so $F = P$ (no time passes, future equals present). If $i = 0$, then $(1+i)^n = 1$ as well, so again $F = P$ (zero interest means no growth). As $n \to \infty$ with $i > 0$, F grows without bound – an indication of exponential growth over long periods.

Use vs. sibling equations: Use this single-payment formula for a **single lump sum** moving forward or backward in time. *For a series of uniform payments, use the annuity formulas instead* (e.g. convert the series to P or A using uniform series factors rather than using this formula on each payment one by one).

Common exam traps:

- **Mismatched units:** Make sure i and n align. For example, if i is given per year but the time span is in months, convert accordingly (or use $i_{\text{per month}}$ with n in months). A common mistake is to plug in n as years when compounding is monthly or quarterly – always

adjust $n =$ (years) $\times$ (periods per year) and use the per-period interest rate.

- **Percentage vs decimal:** Enter interest as 0.08 not 8.0 in calculations. A calculator error like using 5 for 5% will ruin the result – *always convert percentages to a decimal fraction* before using formulas.
- **Forgetting negative exponents:** When finding present worth, use $(1+i)^{-n}$. It's easy under time pressure to mistakenly multiply by $(1+i)^n$ instead of dividing. Remember: future to present requires a division (discounting), which the negative exponent handles.
- **Rounding mid-calculation:** If you must break the calculation into steps (e.g. computing $(1+i)^n$ first), keep enough significant figures. Rounding too early can lead to noticeable error, especially for long periods n.

Exam Handbook Search Cues (Not affiliated with or endorsed by NCEES): *present worth, future worth, annual worth, uniform series, compound amount factor (F/P)*

Footnotes:

- The term **"annual worth"** is often used interchangeably with *equivalent annual cost (EAC)* or *equivalent annual value*. All refer to a uniform annual series equivalent to some lump sum or project net present value.

- **End-of-period convention:** Unless stated otherwise, assume cash flows like A occur at the *end* of each period. Annuity formulas are derived with end-of-period payments. (If you encounter beginning-of-period annuities – rare in FE exam – adjust by an extra compounding period or use the formula $P = A\frac{(1+i)^n-1}{i(1+i)^{n-1}}$ for payments starting at time 0.)

- **Signs (cash flow direction):** In engineering economics, it's common to treat cash *outflows* (costs) as negative and *inflows* (receipts/savings) as positive. The formulas work with either sign, but be consistent. For example, if P is an outflow (investment), then annual revenues A might be positive inflows – their equivalence would come out with a negative P to indicate an initial cost.

- **Interest rate format:** The interest rate i is typically quoted per year on the FE exam (unless specifically stated per month or per quarter). If a problem says "at 6% interest," you can assume $i = 0.06$ per year unless context implies a different period.

Variations & Related Forms:

- **Solving for other variables:** The compound interest equation can be rearranged. For example, to find the number of periods n required for a present sum to grow to a target future value, solve $F = P(1+i)^n$ for n: $n = \frac{\ln(F/P)}{\ln(1+i)}$. To find the interest rate that turns P into F in n periods, solve for i: $i = (F/P)^{1/n} - 1$. These are less common but good sanity checks (e.g. if $F/P = 2$ in 10 periods, the implied i is about 7%).

- **Uniform series formulas:** For a series of equal payments A, there are established formulas derived from the sum of a geometric series.

Two key ones are:

- *Present Worth of Annuity:* $P = A\frac{(1+i)^n-1}{i(1+i)^n}$. This factor $\frac{(1+i)^n-1}{i(1+i)^n}$ is often denoted $(P/A, i, n)$ – the factor to multiply an annual amount by to get its present worth.
- *Capital Recovery (Annual Worth):* $A = P\frac{i(1+i)^n}{(1+i)^n-1}$. This is the inverse of the above, sometimes noted as $(A/P, i, n)$, used to find a uniform annual cost equivalent to a present lump sum P. It's widely used for calculating annualized costs of capital investments. - *(Future Worth of Annuity:* $F = A\frac{(1+i)^n-1}{i}$, the factor denoted $(F/A, i, n)$, to accumulate a series to a future sum. Likewise $A = F\frac{i}{(1+i)^n-1}$ is the *sinking fund factor* (denoted A/F).)

- **Gradient series:** In some problems, cash flows increase by a fixed amount each period (linear gradient). There are formulas (P/G, A/G, etc.) for those too, but if not explicitly needed, don't over-complicate your solution. A gradient can often be handled by converting it into an equivalent annuity plus an extra term. (For example, an increasing series 100,200,300, ... can be seen as a base annuity + a gradient adjustment.)

- **Typical interest rates:** On the FE, interest rates in economic problems are usually single-digit percentages (e.g. 4%, 8%) up to perhaps ~15%. Very high rates or very long timeframes might signal that a special approximation or continuous compounding is intended, but generally stick to standard formulas unless prompted otherwise.

Special Notes – Calculator: All FE-approved calculators can handle these formulas well, but be careful with parentheses. For instance, to compute $A = P\frac{i(1+i)^n}{(1+i)^n-1}$, it's wise to **compute the denominator first** then do the division to avoid mis-keying. On a TI-36X Pro or Casio fx-115, you might enter: ((1+i)^n - 1) [=] then / ((1+i)^n * (1/i)) or similar stepwise to get the factor. A common strategy is to calculate $(1+i)^n$ once, store it (the calculators have a memory or ANS recall), then reuse it in numerator and denominator. This reduces keystroke errors. **Always use decimal format for %**, and consider using the ^ or x^y key for exponents. A quick mental check: if in is small, $P \approx A \times n$ (for very low interest, annuity A times number of years is roughly P); your calculator result should be close to that ballpark. If it's way off, re-check your parentheses and input format.

Explanation (Application & Meaning): The compound interest relationship tells us *how money grows or shrinks over time*. In an FE exam context, you'll use it whenever a problem involves **moving a cash amount to a different point in time**. For example, if a question gives a cost that will occur 5 years in the future and asks for the equivalent cost in today's dollars, you *discount* that future cost back to present using $P = F(1+i)^{-5}$. Likewise, if you have savings each year A for 10 years and want to know how much you'll have at the end, you use $F = A\frac{(1+i)^{10}-1}{i}$. The basic idea is that dollars at different times are connected by the factor $(1+i)^n$ (or its reciprocal).

Why is this important? Because engineering economic decisions require comparing options on an equal time basis. You can't just sum up money values from different years without adjusting for interest – that would be like adding apples and oranges. Instead, you convert all cash flows to a common time (all to present, or all to some future year, or all to an annual equivalent) and then compare. The formulas we reviewed are the tools to make those conversions quickly.

Analysis (Step-by-Step Breakdown):

Let's dissect $F = P(1+i)^n$ term by term: - P is the amount of money you have at the start (time 0). Think of it as the principal in an account. - i is the interest rate per period (say per year). If $i = 0.05$, that's a 5% growth per year. Always check if i is annual or per some other period; if compounding is monthly, an annual rate must be converted (more on that in the next subtopic).

- $(1+i)^n$ is the **growth factor** over n periods. Each period, the money multiplies by $(1+i)$. For example, after 1 period you have $P(1+i)$; after 2 periods, $P(1+i)(1+i) = P(1+i)^2$; and so on. This exponential term is what separates present and future values. It's dimensionless (since i is dimensionless per period and n is a count of periods).

- F is the amount of money after n periods. It includes the original principal plus all accumulated interest. It's in the same units of currency as P. Physically, if you deposit P now at interest i, after n periods you get F.

- If we solve for $P = F(1+i)^{-n}$, each term $(1+i)^{-1}$ is a **discount factor** per period. It's like saying "one dollar in the future is worth $1/(1+i)$ dollars today." So $(1+i)^{-n}$ is the total discount factor for n periods. - For annuities: in $P = A\frac{(1+i)^n-1}{i(1+i)^n}$, the fraction is a sum of geometric series. Each payment A at time t contributes $A(1+i)^{-t}$ to P. The formula packages the sum of all those individual discounted payments. Each parameter: A is the repeating cash amount, n is how many times it occurs, and i as before. By understanding it, you know that if interest i is higher, a given series is worth less in present terms (because $(1+i)^{-t}$ discounts more heavily). If n is larger, more terms add up so P increases (the factor gets bigger with n). And if $i \to 0$, the formula $\frac{(1+i)^n-1}{i(1+i)^n}$ tends to n, meaning $P \approx A \cdot n$ (no interest means present value is just sum of payments).

- **Units check:** Ensure consistency – if i is per year and you counted n as years, then F comes out in the same currency as P. If you accidentally used months for n with an annual i, the calculation would be off. A quick units hack: write i as "(interest per period)" and n as "number of periods" on your paper. This reminds you to express both in compatible terms (e.g. months and months, or years and years).

In using these formulas on the FE exam, the main challenge is often identifying which formula to use and plugging in correctly. Practice by translating word problems into P, F, A, i, n and selecting the matching factor. With repetition, you'll recognize, for example, that *"equal annual payments"* hints at using a A/P or P/A factor, or that *"future value of a single deposit"* is a straightforward use of (F/P). Keep an eye out for keywords and always double-check: Am I moving money forward (compound) or backward (discount)? That mindset will keep your solutions on track.

K04.T01.S02 – Nominal vs Effective Interest Rates (Non-Annual Compounding)

Principle Introduction: Interest rates can be quoted in different ways. A **nominal interest rate** (often denoted r) is an annual rate that does not account for compounding within the year – it's basically a named rate. The **effective interest rate** is the actual interest earned in a year after accounting for compounding. If interest is compounded multiple times within a year (such as monthly or quarterly), the effective annual return will exceed the stated nominal rate. This subtopic covers how to convert between nominal and effective rates, and why it matters: on the FE, you might be given an interest rate with "compounded semi-annually" and need to use the correct rate per period or find the effective annual rate. Understanding nominal vs effective ensures you don't over- or under-count interest in multi-period compounding.

- A **nominal annual interest rate** r is typically stated as "% per year, compounded (period)ly." For example, 12% per year compounded monthly means $r = 0.12$ and compounding periods per year $m = 12$. By itself, r is not used directly in formulas except as a precursor to find the per-period rate.
- The **per-period rate** is r/m. In our example, that's 0.12/12 = 0.01 per month (1% per month).
- The **effective annual interest rate** i_e is the rate that, if applied once per year, would give the same growth as the nominal rate with its compounding. In other words, it's the actual annual growth factoring in all the intra-year compounding effects.
- Why we care: Many economic calculations assume interest rate i is per period of compounding. If you're given a nominal rate with more frequent compounding, you must convert it to the effective per-period rate for use in formulas. Conversely, sometimes you'll need to report an effective annual rate so that different compounding schemes can be compared "apples to apples."

Equation Passport – Effective Annual Interest Conversion: This formula converts a nominal annual rate with frequent compounding into an equivalent effective annual rate. It ensures you account for compounding properly.

Name & purpose: *Nominal-to-Effective Interest Conversion* – computes the **effective annual interest rate** i_e from a nominal annual rate r with m compounding periods per year. Also allows finding the effective rate for any given compounding (or vice versa).

Equation:

$$i_e = (1 + \frac{r}{m})^m - 1$$

Here r is the nominal annual rate and m is the number of compounding periods in one year. *(If you need the effective rate for a different time span, adjust the power. E.g., the effective quarterly rate would be $(1 + r/m)^{m/4} - 1$ for 3 months, but usually we focus on annual.)*

Variables & units:

- r = nominal annual interest rate (as a decimal). Often given as, say, 6% compounded monthly (so $r = 0.06$, $m = 12$).
- m = number of compounding periods per year (dimensionless count). Common values: 12 (monthly), 4 (quarterly), 2 (semiannual), 365 (daily, in some contexts), etc.
- i_e = effective annual interest rate (decimal form). This is the actual annual growth rate accounting for compounding. No separate unit, but "per year" implied.

Assumptions & scope:

- Interest is **compounded evenly** at each of the m sub-periods. That is, each period interest = r/m. This holds for standard bank-style compounding. (If compounding is irregular or continuously, different formulas apply.)
- The formula gives the equivalent interest over exactly one year. To compare investments or loans fairly, always compare their effective annual rates.
- Valid for any $m \geq 1$. As $m \to \infty$, compounding becomes continuous (a limit case discussed below).

Limit tests:

- If $m = 1$ (compounded annually), then $i_e = (1 + r/1)^1 - 1 = r$. As expected, with annual compounding, nominal and effective rates are the same.
- If $m \to \infty$, then i_e approaches $e^r - 1$. For example, with continuous compounding, a nominal rate of 5% yields $i_e \approx e^{0.05} - 1 \approx 0.05127$ (5.127%). The difference is small for moderate r, but noticeable for large r or large m.
- If $r = 0$, trivially $i_e = 0$ regardless of m (zero nominal rate gives zero interest effectively).

Use vs. sibling equations: Use this equation to **convert a stated nominal rate to the rate per year or per period** that you need in calculations. For instance, if a problem gives a nominal rate and asks for future value after non-integer years, you might find the effective rate per smaller interval. A sibling concept is converting an effective rate to a nominal – for example, to find what nominal rate with quarterly compounding corresponds to a desired effective rate, you solve $i_e = (1 + r/m)^m - 1$ for r. Another related formula is for **continuous compounding**: $i_{\text{cont}} = e^{r_{\text{cont}}} - 1$ (where r_{cont} is the nominal continuous rate). But continuous compounding is rarely needed unless explicitly mentioned.

Common exam traps:

- **Using r when i is needed:** If a formula calls for i per period and you plug in r, you'll overcount interest. Always divide r by m for per-period calculations. For example, in $F = P(1 + i)^n$, if interest is 8% compounded quarterly and n is years, use $i = 0.08/4 = 0.02$ and $n =$ number of quarters. A mistake here can produce answers off by significant margins.
- **Mixing up compounding periods:** Sometimes exams give interest over different intervals (e.g. "6% compounded quarterly, find equivalent semiannual rate"). Make sure to convert through effective annual as an intermediate if needed. In that example, 6% nominal quarterly → find i_e → then find nominal semiannual that yields same i_e. It's easy to do too many or too few compounding steps if you don't proceed systematically.
- **Forgetting to subtract 1:** The formula has "−1" at the end. If you just compute $(1 + r/m)^m$, that's the growth factor (i.e., F/P over one year). To get the interest rate itself, you must subtract 1. Missing this will give you a number around 1.x (like 1.0617 for 6% at m=12) instead of 0.x (0.0617, the effective rate).
- **Rounding issues:** If asked for an effective rate as a percentage, be mindful of rounding. For instance, $i_e =$ 0.061677... can be stated as 6.17% if needed. Over-rounding intermediate results (like using 6.2% in subsequent calcs) can introduce small errors. Keep a few extra decimal places until final answers.

Exam Handbook Search Cues (Not affiliated with or endorsed by NCEES): *nominal rate, effective interest, nonannual compounding, (1 + r/m)^m*

Footnotes:

- **APR vs nominal:** In everyday finance, "APR" (annual percentage rate) is essentially a nominal rate r (often for loans, not accounting for compounding within the year). The FE exam will usually just call it nominal interest rate. APR and nominal can be used interchangeably for our purposes here.

- **When m is not annual:** Occasionally interest might be quoted per quarter or per month explicitly (e.g. "2% per month"). In that case, m is implicit (12 months in a year if you need annual). For calculation consistency, convert everything to either per year or per period of payment. If payments happen monthly, work with monthly rate; if you need annual comparison, convert to effective annual.

- **Continuous compounding:** The theoretical limit of compounding frequency is continuous compounding. The formula for effective rate becomes $i_e = e^{r_{\text{cont}}} - 1$. Conversely, a nominal continuous rate that yields i_e is $r_{\text{cont}} = \ln(1 + i_e)$. While not commonly needed on the FE, it's good to know the concept in case a problem references "compounded continuously" (then use $F = P\,e^{rt}$ for growth over t years).

- **Effective vs. Equivalent:** The term "effective rate" typically means an annualized rate that yields the same accrued interest. "Equivalent rate" can mean the same thing or refer to a rate over a different period that yields the same growth. For example, "what is the equivalent monthly rate for 6% effective annual" – you'd solve $\left(1 + i_{\text{monthly}}\right)^{12} - 1 = 0.06$.

Variations & Related Forms:

- **Finding per-period rate:** You can use the same formula to find the effective rate for one compounding period of a nominal rate. Trivially, that is $i_{\text{per period}} = r/m$. For example, nominal 12%/year compounded monthly → 1% per month. Ensure you use this $i_{\text{per period}}$ in formulas that step through each period (like if you do $F = P(1 + 0.01)^{12}$ to get one year growth, which indeed gives the same as the formula above).

- **Effective *monthly* or *daily* rates:** If needed, you can find the effective rate for any interval. Suppose you want the effective quarterly rate for 8% APR compounded monthly. First find i_e annual = $(1 + 0.08/12)^{12} - 1 = 0.082999...$ (8.2999%). Then effective quarterly rate is the rate that over 4 quarters yields that same growth: solve $\left(1 + i_q\right)^4 - 1 = 0.082999$. That gives $i_q = (1.082999)^{1/4} - 1 \approx 0.0202$ (2.02% per quarter effective). This approach is useful if you need to compare cash flows on a different compounding basis.

- **Approximation for small i:** When i is small or compounding frequency is high, $i_e \approx r + \frac{r^2}{2m}$... (but usually just remember $i_e > r$ if $m > 1$). A quick mental check: if compounding semiannually, effective ≈ a bit higher (e.g. 10% nominal → 10.25% effective).

- **Loan vs investment context:** Sometimes nominal vs effective is framed as APR vs APY (annual percentage yield). If you deposit money at a bank at 6% compounded monthly, you earn 6.17% actual in a year – the bank may advertise the APY = 6.17%. If you borrow on a credit card at 18% APR compounded monthly, the effective interest you pay is about 19.6% annually. The FE won't delve into consumer finance details, but these concepts underpin the calculations.

Special Notes – Calculator: Your FE exam calculator likely has a y^x or exp function to handle $(1 + r/m)^m$ easily. On a Casio or TI, you can compute effective rates in one line: e.g., input ((1 + 0.06/12)^12 - 1) = and get 0.061677... for 6% comp monthly. **Be cautious with older HP models in RPN mode** – you might do 1 0.06 12 / + 12 y^x 1 - to get the result. It's easy to forget the last "-1". Another tip: store intermediate $1 + r/m$ in memory if doing multiple steps. And remember, if you're chaining this into another formula (say using i_e in a present worth calculation), avoid rounding i_e too much. Use the value directly from calculator memory if possible to maintain precision.

Explanation: When dealing with nominal vs effective rates on the FE exam, you're usually in one of two situations:

(1) You're given a nominal rate with a compounding frequency and need to use it correctly in time-value formulas, or

(2) you need to compare two rates with different compounding. In case (1), the strategy is: convert the nominal rate into the **actual per-period rate** that matches your cash flow periods. For example, if a problem says "5% interest compounded quarterly for 2 years," interpret that as $r = 0.05, m = 4$. The per-quarter rate is $0.05/4 = 0.0125$. And for 2 years there are $n = 8$ quarters. So you would use $i = 0.0125$ and $n = 8$ in formulas like $F = P(1 + 0.0125)^8$.

In case (2), if asked "which bank account yields a higher return: 4.0% compounded monthly or 4.1% compounded annually?", you compute the effective annual for the first: $i_{e1} = (1 + 0.04/12)^{12} - 1 \approx 0.0407(4.07$. Compare that to 4.1% (which is already effective since annual compounding). You'd conclude 4.1% annually is slightly better.

The key understanding is **interest compounding makes a difference**: more frequent compounding → more interest earned (or paid) in real terms. On short time scales or low rates the difference is small, but you should never ignore it on a problem because the exam answers will reflect the correct effective values. It's also worth noting that if you need to find the value of an investment after a fractional number of years with non-annual compounding, you have options: break it into periods or find an effective rate for that fractional period. For example, "6% compounded monthly for 3.5 years" – you could compute for 42 months (which is straightforward), or find effective 3.5-year growth via $(1 + 0.06/12)^{42}$ directly. Both yield the same result. Choose the method that reduces chance of error.

Analysis: The formula $i_e = \left(1 + \frac{r}{m}\right)^m - 1$ can be understood by building it up: - $\frac{r}{m}$ is the interest per compounding period. If $r = 0.12$ and $m = 12$, that's 1% per month. - $1 + \frac{r}{m}$ is the growth factor for one compounding period (e.g. 1.01 per month). - $(1 + \frac{r}{m})^m$ is the growth factor after one full year of compounding those periods. It's like saying, start at 1 (for 1 dollar), each month multiply by 1.01; after 12 months you have $(1.01)^{12} \approx 1.1268$ if $r = 0.12$. This value is how much \$1 grows to in a year. - Subtracting 1: $(1 + \frac{r}{m})^m - 1$ then leaves just the decimal interest portion. In the example, that's 0.1268, meaning **12.68% effective**. So nominal 12% comp monthly actually yields 12.68% in a year.

- Every time you deal with interest, ask "what period is this rate for?" If you see i in a formula like $F = P(1 + i)^n$, know that i is the interest per period *corresponding to the increment of* n. If n counts years, i must be per year effective. If n counts months, i must be per month.

- The nominal rate r is more of a *communication tool* – it's not directly plugged in unless the formula specifically is derived for it. A nominal rate is useful when you want to quickly compare basic interest levels, but calculations need the actual per-period rate.

- One common application on the exam: **effective vs nominal for inflation or investment returns**. For instance, "If inflation is 6% compounded monthly, what is the effective annual inflation rate?" You would do the same process: $(1 + 0.06/12)^{12} - 1 \approx 6.17$. The difference might matter in a real vs nominal interest calculation (next subtopic). - Another perspective: If you receive interest m times a year, each time you're earning interest on interest from previous periods except the first. That extra bit is what makes i_e slightly larger than r.

Always double-check your reasoning: if compounding is more frequent, i_e should come out higher than r. If your calculation gives a lower number, something's off (perhaps you divided when you should have multiplied or vice versa).

At exam time, remember: **convert, then compute.** Convert the rates to the right form (nominal ↔ effective) *before* plugging into the money formulas. This two-step process will save you from a lot of compounding confusion.

Topic Wrap-up (Summary): *Nominal vs effective interest summary*

- **Nominal rate** r – Annual rate quoted, with compounding frequency specified (e.g. "annual rate 6% compounded monthly"). Use for communication; convert it for calculations.
- **Per-period rate** – r/m. Use this in formulas if you break time into m periods per year. *(Ensure n is total number of periods.)*
- **Effective annual rate** i_e – The actual annual growth. $i_e = \left(1 + \frac{r}{m}\right)^m - 1$. Use to compare different compounding or when needing one rate for a full-year cash flow conversion.
- **Effective per period** (for periods less or more than a year) – e.g. effective quarterly = $\left(1 + \frac{r}{m}\right)^{m/4} - 1$ if you want the 3-month equivalent of that nominal r. Or simply $(1 + i_e)^{1/4} - 1$.
- **Calculator tip:** Always use **DECIMAL** form for rates and be mindful of grouping in formulas. Many errors come from, say, doing $1 + 6/12$ in a calculator (which yields 1.5 instead of 1.005) because of order of operations. Write $1 + (0.06/12)$ explicitly.

K04.T01.S03 – MARR Concept & Real vs Nominal Interest (Inflation-Adjusted Rates)

Principle Introduction: In engineering economy problems, we often have to consider **minimum attractive rate of return (MARR)** and the effect of **inflation** on interest rates. MARR is a decision criterion: This is a benchmark discount rate chosen by the

organization. Projects are evaluated by discounting their cash flows at this rate, and only those whose returns meet or exceed it are considered financially acceptable. If a project's internal rate of return (IRR) is below the MARR, the project is not economically attractive. This concept helps in go/no-go decisions and is usually given in problems as a percentage that you must compare against or use in calculations.

Meanwhile, **inflation** causes the **nominal interest rate** (the market rate of interest including inflation) to differ from the **real interest rate** (the inflation-adjusted rate, reflecting true purchasing power gain). When prices inflate, some of the interest earned is just compensating for that inflation rather than providing real gain. The FE exam may ask you to compute a real interest rate given an inflation rate, or vice versa, or to use real vs nominal rates appropriately when discounting **constant dollars** vs **actual dollars**. Understanding the relationship between real and nominal interest is key when problems involve inflation or cost escalations.

- **MARR (Minimum Attractive Rate of Return):** Essentially a hurdle rate. It's set by an organization based on cost of capital, risk, and opportunity cost. For FE purposes, you might simply use the given MARR as the interest rate to compute present worth or annual worth of a project's cash flows, then decide if the result is ≥ 0 (acceptable) or not. Think of MARR as "the interest rate at which we're indifferent"; any project must beat this rate to be worthwhile.
- **Nominal vs Real interest:** Nominal interest i_{nom} is the rate you'd typically get from a bank or see in a loan, which includes the effect of inflation. Real interest i_{real} is adjusted so that it represents growth in terms of purchasing power, excluding inflation. They are related by the approximate formula $i_{\text{real}} \approx i_{\text{nom}} - f$ (where f is inflation rate) for small percentages, but exactly by the formula below.

Equation Passport – Inflation-Adjusted Interest (Real vs Nominal): This formula connects real interest rate, nominal interest rate, and inflation rate. It is often called the Fisher equation in finance (exact version).

Name & purpose: *Real Interest Rate Formula* – calculates the real interest rate i_{real} given a nominal interest rate r_{nom} and an inflation rate f. It shows how to adjust interest for inflation effects. (It can also be rearranged to find nominal given real and inflation.)

Equation:

$1 + i_{\text{nom}} = (1 + i_{\text{real}})\,(1 + f)$. Equivalently, $i_{\text{real}} = \frac{1+i_{\text{nom}}}{1+f} - 1$

Variables & units:

- i_{nom} = nominal interest rate (often an annual market rate, decimal form). This is the "market" or "actual" interest including inflation.
- f = inflation rate (decimal). Typically annual general inflation (e.g. consumer price index increase).
- i_{real} = real interest rate (decimal). This is the interest rate in terms of constant purchasing power.
- All are dimensionless rates per the same time period. Usually per year. Make sure f and i_{nom} both correspond to say yearly rates if you're finding yearly i_{real}.

Assumptions & scope:

- Inflation is given as a uniform rate f per period. The formula assumes a relatively steady inflation scenario (which is fine for exam problems).
- Nominal and real rates are small enough that the product $i_{\text{real}} \times f$ is not huge (the formula is exact regardless of size, but intuitively large rates compound a bit dramatically).
- Use this equation when you need to convert cash flows measured in **actual dollars** (inflated currency) to **real terms** (constant dollars) or vice versa. It's particularly useful if a problem says "all dollars are in today's terms" – then you'd use a real interest for discounting; if dollars are future actual amounts, use nominal.

Limit tests:

- If $f = 0$ (no inflation), then $1 + i_{\text{nom}} = (1 + i_{\text{real}})(1 + 0)$ so $1 + i_{\text{nom}} = 1 + i_{\text{real}}$. Thus $i_{\text{nom}} = i_{\text{real}}$. No inflation means nominal and real interest are the same, as expected.
- If $i_{\text{nom}} = 0$ (say a zero-interest scenario but with inflation), the formula gives $1 = (1 + i_{\text{real}})(1 + f)$. Then $i_{\text{real}} = \frac{1}{1+f} - 1 \approx -f$. So with zero nominal interest and positive inflation, the real interest is negative (your money loses purchasing power).
- For small rates, $i_{\text{real}} \approx i_{\text{nom}} - f$. The exact formula has the $+i_{\text{nom}}f$ term in the expansion, which for typical exam-sized rates (a few percent) is second-order small. E.g. if $i_{\text{nom}} = 0.08, f = 0.03$, then $i_{\text{real}} = (1.08/1.03) - 1 \approx 0.0485(4.85$. The simple difference $0.08 - 0.03 = 0.05$ was a bit higher (5%), overestimating real rate slightly due to ignoring the if term.

Use vs. sibling equations: Use this formula whenever you need to **deflate or inflate interest rates**. Specifically, if a problem provides an interest rate "in real terms" or asks for an analysis "in today's dollars," you should use real interest. If it provides "actual dollars" with inflation, use nominal interest. This equation helps toggle between the two. A sibling concept is adjusting cash flows themselves for inflation (e.g. escalating costs each year by an inflation rate, then discounting at nominal). But an easier approach often is to convert to real by deflating the interest rate.

Common exam traps:

- **Mixing up when to use real vs nominal:** A frequent confusion is whether to discount with a nominal or real rate. A simple rule: *discount actual dollars with nominal rate; discount constant dollars with real rate*. If a problem gives cash flows "in current dollars" (no inflation considered in the amounts), use a real rate for NPV. If cash flows are given year-by-year with an inflation applied, use nominal. The exam might hint this by saying "neglect inflation" (use nominal = real in that case since f=0 effectively).
- **Confusing direction of adjustment:** Remember $i_{\text{real}} = \frac{1+i_{\text{nom}}}{1+f} - 1$. Some mistakenly multiply by $1 + f$ instead of divide. A good way to remember: nominal is bigger than real if inflation is positive (because nominal has inflation

built in). So if you're finding a real rate from a larger nominal, you *divide out* the inflation factor (thus the division by $1 + f$). If you go from a real to nominal, you *multiply* by $1 + f$ then subtract 1.

- **Using f in place of i:** Inflation f is *not* an interest rate you use for discounting cash flows directly (unless you're specifically converting amounts to real dollars first). Don't treat inflation as a negative interest; instead adjust the interest. For example, do not subtract inflation from cash flows – correct approach is either adjust the rate or adjust the cash flows by inflating them.
- **Forgetting to adjust MARR if needed:** If a problem states a MARR in real terms but gives cash flows in actual dollars (or vice versa), you need to align them using the formula. Many forget to do this and apply MARR directly to whatever cash flows given, which could be wrong if one is nominal and the other real. Always check: is the MARR given accounting for inflation or not? The FE might specify "a real MARR of X%" meaning you should use that as i_{real}.

Exam Handbook Search Cues (Not affiliated with or endorsed by NCEES): *MARR, minimum attractive rate, real interest, nominal interest, inflation rate*

Footnotes:

- **MARR usage:** On exam problems, you'll usually use MARR as the discount rate in NPV (net present value) or as the rate to compute an annual worth. It's basically the threshold: if NPV ≥ 0 at MARR, the project meets the minimum return. If a question asks something like "should the project be accepted at a MARR of 10%?", you'd compute the project's net present worth at 10% and check the sign (positive = accept). The MARR itself is typically given, not something you calculate.

- **Inflation terminology:** "Real dollars" or "constant dollars" mean dollars valued at a base time (no inflation effect included in values). "Then-current dollars" or "actual dollars" mean the amounts include inflation over time. Watch for these phrases; they tell you whether to use real or nominal rates. Sometimes a problem might say "all cash flows are in today's dollars" – that implies use real interest (deflated).

- **Inflation in calculations:** If you choose to, you can always solve problems in nominal terms: inflate all cash flows year by year at rate f, then discount with nominal i_{nom}. This yields the same answer as taking un-inflated cash flows and discounting with i_{real}. The latter is usually less work if inflation is just a general background rate. So it's often easier to deflate the interest rate and use constant cash flows.

- **Interpretation of real interest:** If i_{real} comes out, say, 3%, that means your money's purchasing power is growing 3% per year. If inflation was 5% and nominal was 8%, that 3% real tells you effectively you're gaining 3% worth of extra goods you can buy each year. If real is negative, you're actually losing purchasing power even though nominal might be positive.

Variations & Related Forms: - Finding nominal from real: Rearranging $1 + i_{\text{nom}} = (1 + i_{\text{real}})(1 + f)$, we get $i_{\text{nom}} = (1 + i_{\text{real}})(1 + f) - 1$. This might be needed if, for example, you're given a desired real return and an inflation forecast, and you want to find what nominal interest you should charge in a contract.

- **Combined rate for discounting with inflation (d):** Sometimes the formula is written as $d = i_{\text{real}} + f + i_{\text{real}}f$, where d is essentially i_{nom}. This is just an expanded form: $d = i_{\text{nom}} = i_{\text{real}} + f + i_{\text{real}}f$. For small rates the $i_{\text{real}}f$ term is tiny, but for completeness it's included. If you see this form, know it's the same relationship.

- **Use in calculations:** Imagine an FE question: *"Inflation is 4% and the real MARR is 8%. What is the equivalent nominal MARR?"* You'd compute $i_{\text{nom}} = (1 + 0.08)(1 + 0.04) - 1 = 1.1232 - 1 = 0.1232 \rightarrow 12.32$. Another: *"A project's cash flows are given in actual dollars with 3% inflation. If MARR (real) is 5%, should the project be accepted?"* Here, either inflate MARR to nominal or deflate cash flows. It might be quicker to get nominal MARR = (1.051.03-1)=0.0815 (8.15%), then discount actual cash flows at 8.15%. Either method yields the same NPV sign. - Inflation in multi-year cash flows: Sometimes specific costs might inflate at different rates (like energy costs rising at 2% while general inflation 3%). The exam usually keeps it simple: one general inflation rate. But if not, you might have to inflate those particular cash flows separately. The real vs nominal formula would then apply per specific inflation if needed. However, that's advanced; most likely, they stick with one f.

- **MARR vs IRR:** MARR is a criterion rate you choose. IRR (internal rate of return) is the rate that makes NPV zero for a project's own cash flows. A project is acceptable if IRR ≥ MARR. The FE might not ask you to compute IRR in this section (it could in broader economic analysis), but it might expect you to understand that comparison.

Special Notes – Calculator: There's typically no direct calculator function needed for MARR or the real/nominal conversion beyond basic arithmetic. If you're computing $i_{\text{real}} = \frac{1+i_{\text{nom}}}{1+f} - 1$, just be cautious with parentheses. For instance, on a calculator: (1 + i_nom)/(1 + f) - 1. Doing it stepwise: first compute $1 + i_{\text{nom}}$, then divide by $1 + f$, then subtract 1. It's straightforward, but easy to slip if you try to do all in one line without careful bracketing. If using an HP in RPN mode, you'd do 1 i_nom + 1 f + / 1 -. As for MARR usage, any present worth or future worth calculation just uses MARR as the interest rate i. No special function; just ensure you've got the right value (real vs nominal) plugged in. One thing to remember: the exam's provided handbook likely lists the formula in one of the forms (either the ratio form or expanded). You can search the handbook PDF for "inflation" or "MARR" to confirm the exact phrasing, but the relationship will be the same as we've stated.

Explanation: Let's put MARR and real vs nominal in a practical context. Suppose you're evaluating a project that costs \$100k now and will return \$150k in five years. You are told the company's MARR is 10% (nominal) and expected inflation is 3% per year. To see if the project meets the MARR, you should compare the project's rate of return or its net present value against that hurdle. One way: compute the present worth of \$150k in five years at the MARR (nominal 10%). First, if \$150k is an *actual dollar* amount in 5 years (meaning it will be \$150k in year 5's money), discount it at nominal 10%: $P = 150{,}000 \times (1 + 0.10)^{-5} \approx 93{,}100$ (just as an example calculation). That present value is less than the \$100k cost, so NPV = 93.1k - 100k = -\$6.9k, which is negative. So at 10% nominal, it fails the criterion (don't do the project). Alternatively, you could have converted that 10% MARR to a real MARR: $i_{\text{real}} = (1.10/1.03) - 1 \approx 6.8$. Then take the \$150k but express it in today's dollars (deflate it 5 years at 3%: $150k/(1.03)^5 \approx 129.5k$ in today's dollars). Discount that at 6.8% for 5 years… actually, if we deflated the cash flow already, we'd just compare $129.5k$ in constant dollars to \$100k directly with real MARR: $129.5k$ at 6.8% over 5 years back to present yields the same 93.1k. The consistency

check: either method agrees. The point is, you have to be consistent – either work entirely in nominal terms (actual dollars and nominal i) or entirely in real terms (constant dollars and real i).

The exam might not involve such multi-step analysis overtly, but it can implicitly test if you know to use the right interest. For example, *"Given an inflation rate, what is the real value of a $10,000 cost incurred 3 years from now?"* Here, "real value" means in today's dollars. You'd deflate $10,000 by inflation: real value = $10000/(1+f)^3$. If they instead asked "What is the present worth at 8% real interest?" and gave cash flows in actual dollars, you'd first convert 8% real to nominal (or convert cash flows to real).

As for MARR concept questions, they might simply state the definition or use it in a decision. E.g., *"The MARR for a company is 12%. Project A has IRR of 15%, Project B has IRR of 10%. Which projects are acceptable?"* – Answer: A is acceptable (15 > 12%), B is not (10 < 12%). Or, *"If the MARR is 8%, what is the equivalent annual worth of this project?"* – then you'd use 8% as your interest rate to find annual worth A of the project's cash flows. MARR basically flags the interest rate to be used in evaluation.

Analysis: The relationship $1 + i_{\text{nom}} = (1 + i_{\text{real}})(1 + f)$ can be interpreted like this: - $1 + i_{\text{nom}}$ is the growth of money in nominal terms after one year. For example, if nominal interest is 12%, $1 + i_{\text{nom}} = 1.12$. $1 becomes $1.12 in a year.

- $1 + f$ is how much prices (and money value) inflate in a year. If inflation is 3%, $1 + f = 1.03$. That means something that cost $1.00 a year ago costs $1.03 now. - $1 + i_{\text{real}}$ is the factor by which purchasing power grows. If real interest is, say, 0.085 (8.5%), then $1 + i_{\text{real}} = 1.085$. $1 worth of purchasing power becomes 1.085 in terms of goods.

- The equation says: *Nominal growth = real growth × inflation growth.* Using numbers: 1.12 (12% nominal growth) = 1.085 (8.5% real growth) × 1.03 (3% inflation growth). Indeed, 1.085*1.03 = 1.11755 (~1.12 when rounded). This means of the 12% nominal gain, 3% was just to keep up with rising prices, and ~8.5% was actual extra value.*

- Each term's units: these are dimensionless factors. It's essentially a multiplicative way of combining rates. If you prefer addition: $i_{\text{nom}} \approx i_{\text{real}} + f$ *for small values, with a correction for the product* $i_{\text{real}} f$.

- MARR itself doesn't appear in the formula, but conceptually: if given a MARR, know whether it's nominal or real. The problem usually implies it. If the analysis is all in constant dollars (sometimes indicated in project evaluation context), they likely gave a real MARR. If not mentioned, assume nominal (which is the default interpretation).

- When solving FE problems, be systematic: label your rates. Write $f = 0.x$ *for inflation,* $i_{\text{nom}} = 0.y$ *and maybe* $i_{\text{real}} = ?$. *It helps avoid plugging in wrong places. - A physical sense of real vs nominal: say your savings account nominally grows 5% in a year, but inflation was 5% too – in real terms you gained nothing; your money's purchasing power is flat. That would be* $i_{\text{real}} = (1.05/1.05) - 1 = 0$. *If inflation was higher than your nominal yield, real interest becomes negative (your money can buy less stuff than before, despite the larger number of dollars).*

- The MARR being real or nominal will dictate whether you should include inflation in cash flows. If MARR is real (no inflation in it), you must use constant dollar cash flows (remove inflation from them) to judge properly. If MARR is nominal, use actual inflated cash flows. In either case, you could do the opposite by converting the MARR accordingly, but one path will usually be simpler given the data presentation.

To wrap up: **MARR is your cutoff rate for investment acceptance, and real vs nominal interest tells you how to handle inflation in economic calculations.** Keeping these straight ensures you discount and compare cash flows on the correct basis. In the FE exam, if you see any mention of "inflation" or "real rate," immediately recall this formula and decide whether you need to adjust the given rates or cash flows. It's a small extra step that can make a big difference in getting the correct result for present worth or equivalent cost problems that involve rising prices.

K04.T01.S04 – Using Standard Interest Factor Tables (P/A, A/F, P/G, etc.)

Principle Introduction: Interest factor tables are a handy reference tool for time value of money calculations. They condense the formulas we've discussed (like $P/A, A/P, F/P, P/F$, etc.) into tabulated factors for various interest rates and periods. In the context of the FE exam, the *exam handbook provides formula relationships* for these factors, and older textbooks or references often include actual numeric tables. While the computer-based exam might expect you to use formulas or your calculator rather than look up numeric tables, understanding the notation and how to use these factors is crucial. It speeds up recognition of what formula is needed and often the exam may phrase questions like "using factor notation" or give you factor values implicitly.

The standard factors and their notations:

- $(F/P, i, n)$ – "Future given Present" factor = $(1+i)^n$. Multiply by a present amount to get its future value.
- $(P/F, i, n)$ – "Present given Future" factor = $(1+i)^{-n}$. Multiply by a future amount to get present value.
- $(P/A, i, n)$ – "Present given Annuity" factor. Multiply by an annual amount A to get present worth P. (This is $\frac{(1+i)^n - 1}{i(1+i)^n}$.)
- $(A/P, i, n)$ – "Annuity given Present" (capital recovery factor). Multiply by a present amount to get the equivalent annual A. (This is $\frac{i(1+i)^n}{(1+i)^n - 1}$.)
- $(F/A, i, n)$ – "Future given Annuity" factor. Multiply by a yearly A to get the accumulated future F. (Formula $\frac{(1+i)^n - 1}{i}$.)
- $(A/F, i, n)$ – "Annuity given Future" (sinking fund factor). Multiply by a future amount needed to find the required uniform deposit A. (Formula $\frac{i}{(1+i)^n - 1}$.)

Gradient factors: $(P/G, i, n)$ for present worth of a linearly increasing series, $(A/G, i, n)$ for equivalent annuity of a gradient, etc.. These are less common, but they exist for cash flows that increase by a constant amount each period.

These factors are typically organized in tables by interest rate and period. For example, you might see a snippet: at i=5%, n=10: $P/A = 7.722, A/P = 0.1295, F/A = 12.578, P/F = 0.6139, F/P = 1.6289$ (just illustrative numbers). Using such a table, one

could directly pick the factor rather than computing the formula each time.

On the FE exam, **the reference handbook lists the formulas, not a full numeric table**, but you might get a factor value indirectly. For example, a question might state: "At 8% interest, the present worth factor for 5 years (P/A, 8%, 5) is 3.9927. Use this to find… etc." Or it might just expect you to compute it. Either way, knowing the factor notation helps decode what the problem is asking.

Using factor tables vs formulas: In study or open-book context, factor tables save time by avoiding on-the-fly calculation. In the exam, since you have a calculator, you can always compute if needed. But recognizing a factor in notation can save you from deriving formula under pressure. E.g., seeing "find A given P" immediately suggests using $A = P(A/P, i, n)$.

Table Passport – Standard Interest Factors: The following outlines how to navigate and use interest factor tables or formulas quickly during the exam.

- **Table title and purpose:** *Interest Factor Table* – a compiled list of time value conversion factors. Each factor allows conversion between two types of cash flow equivalents (single sum ↔ single sum, single sum ↔ uniform series, uniform series ↔ uniform series, etc.) for a given interest rate i and number of periods n. The table's purpose is to eliminate the need to derive or memorize complex formulas during the exam; you can directly pick the factor by knowing its notation.
- **How to read and interpolate:** Typically, rows of the table are indexed by n (number of periods) and columns by interest factors for a specific i. If a table excerpt is given, find the row for the relevant n and read off the factor under the desired column (F/P, P/A, etc.). **Interpolation** is rarely needed on the FE exam since n and i are usually exact. If an interest rate is between table entries, it's safer to calculate directly with the formula than to interpolate, unless the exam specifically suggests a linear approximation (which is uncommon for these factors because the relationship is not linear in i).
- **Units and source lineage:** All factor values are dimensionless (they're ratios of monetary amounts). They've been derived from the fundamental formulas (which we've covered). The exam handbook provides the formulas for each factor but not precomputed numeric values. Any numeric table you use in studying (from textbooks) is just computed cases of those formulas. On the exam, you'll rely on either memory, quick calculation, or possibly a provided snippet in the question. The **notation (P/A, A/F, etc.)** is standard and is used in the handbook and many references.

Typical exam moves:

- Recognizing keywords: if a question asks for "annual worth," you should think of the A/P factor (to find A given a present cost) or A/F (if converting a future requirement to annual deposits). If it asks for "present worth of an annuity," think P/A.
- Using the handbook: The moment you see something like "uniform series" or a factor notation in the problem, you can search the electronic handbook for that factor formula. For example, searching "P/A" will jump to the present-worth-of-annuity formula. Then you can plug in numbers. This is often faster than deriving the formula from scratch under pressure.
- Shortcut usage: If a factor value is directly given in a problem statement (they sometimes do to save calculation time or to see if you recognize what to do with it), just multiply or divide by that factor as appropriate. For instance, "Using i=10%, for n=5 the factor (P/F,10%,5) = 0.6209. What is the present worth of $1000 received in 5 years at 10%?" You'd simply do $1000 * 0.6209 = $620.9.
- Table lookup vs calculator: If you're quick with a calculator, you might ignore tables and compute $(1.1)^{-5}$ yourself. That's perfectly fine. The key is understanding what needs to be computed – the table notation bridges that understanding.

Common pitfalls:

- **Misidentifying factors:** It's easy under stress to confuse, say, P/A with A/P. A good trick: look at the units conceptually. P/A should yield a factor with units of "years" roughly, because multiplying an annual amount by it gives a larger lump sum. A/P yields a number usually less than 1 (for positive i), because you're finding a smaller annual amount equivalent to a larger present amount. If you accidentally use the wrong factor, the magnitude of your answer will be off (e.g. using P/A when you needed A/P will invert the result). Double-check: if you're expecting an annual payment smaller than the present cost (for positive interest), use A/P.
- **Forgetting to adjust n or i:** The tables (and formulas) assume every period has the same i and you have a whole number of periods n. If a question effectively has a fractional period or changing i, you cannot directly use a single factor. Don't try to shoehorn the factor tables into situations they don't fit (e.g. two different interest rates over different intervals – you'd have to break the problem in parts).
- **Mixing up gradient vs annuity factors:** The presence of G (gradient) factors in the handbook means if you search P/G, you might get that formula. Ensure you're using the correct one. Gradient factors handle series that increase each period by a constant amount. Don't use P/G thinking G is just "general" – it specifically means gradient. For level series, use P/A or A/P.
- **Relying on memory without understanding:** Some students try to memorize all factor formulas. It's more important to know *when* to use each. The handbook has them; you just need to identify which one to pull out. So focus on the logic: P given A (present worth of series), A given P (capital recovery), etc. Then you won't pick the wrong one.
- **Wrong factor direction:** If an answer seems off, consider whether you should have inverted a factor. The table values for P/A and A/P are reciprocals. Same for F/P and P/F, A/F and F/A. If you can't find a certain factor, remember you can invert another: e.g., if you only have P/A table, you can get A/P by taking its reciprocal (though calculation might be needed).

Exam Handbook Search Cues (Not affiliated with or endorsed by NCEES): *P/A factor, capital recovery, sinking fund factor, uniform gradient*

Footnotes:

- The FE Reference Handbook's *Engineering Economics* section explicitly lists these factor formulas under a table. While it doesn't give a numeric table, it defines the terms. For example, it defines "Capital Recovery (A/P)" and gives the formula. Being familiar with those entries means faster lookup if needed. - **Symbols recall:** A = uniform series amount, P = present worth, F = future worth, G = uniform gradient amount. When scanning the handbook or tables, it helps to recall these quickly. If you see a factor like A/F, mentally translate: "to get A given F, multiply F by (A/F)". If you forget which way around, look at the units or dimensions as discussed.

- **No need to memorize numeric values:** Unlike in some college exams where you might have a printed interest table, here you're not expected to memorize that e.g. (P/A,10%,5)=3.790. But you should know how to get it if needed (compute or find formula). If there are any commonly used factor values, perhaps extremely simple ones like (P/A, i=0, n) = n (for zero interest) or maybe (P/A,5%,10) ~ 7.72 as earlier, but it's not required.

- **Using I-values on calculator:** Some calculators (like certain HP models or financial calculators not allowed in FE though) have built-in financial functions for annuities (like computing payment given present, etc.). The FE-approved calculators are scientific, not financial, so you won't have an "N, i%, PV, PMT, FV" interface. However, you can still solve those with equations or iterative trial if needed (for IRR for example). But since we stick to basics, rely on the formulas.

- **Double-check factor for reasonableness:** After you either compute or recall a factor value, quickly sanity-check. For instance, (P/A, 10%, 5) should be somewhat less than 5 (because discounting makes it less than just 5 times one payment). If you got a number like 10, that's clearly off. Or (A/P, 10%, 5) should be around 0.26 (1/3.79); if you got 3.79 by accident, you used the wrong factor (that's P/A). These intuitive checks can catch mistakes.

Variations & Related Forms: - **Uneven series:** If cash flows aren't uniform or a simple gradient, factor tables don't directly apply for the whole series. You might break the series into parts that are uniform or single sums and handle each with factors. This is a common approach: split complex cash flows into sum of simpler components (some annuities + some single amounts).

- **Geometric gradients:** There are cases with cash flows growing by a percentage rather than a fixed amount (geometric gradient). That enters a different formula (related to inflation and real interest effectively). The FE likely won't require deriving geometric gradient present worth, but if needed, you'd convert each year's cash separately or use a modified approach (beyond our current scope).

- **Using factors in reverse:** If a problem provides a factor value in text, you can use it to find n or i by trial or interpolation. For example, "find the interest rate at which (P/A, i, 5) = 4.5." You would know $4.5 = \frac{(1+i)^5-1}{i(1+i)^5}$ and solve for i. This might require some iteration. It's rare on FE to solve for i in an annuity factor (more common in IRR problems to solve for interest given NPV=0), but just be aware it could be approached by trial with table values if multiple-choice options are given (you could test each choice).

- **Special case factors:** $n = \infty$ (infinite periods) for P/A becomes $1/i$ (this is how you get the perpetual series present worth, sometimes used in capitalized cost calculations). If you see "perpetual annual cost" or "capitalized cost", remember $P = A/i$ for perpetual, which is the limit of P/A as $n \to \infty$. The tables/formulas usually assume finite n, but it's a logical extension and sometimes explicitly noted.

- **Choosing between P→F vs F→P:** Some problems might have you calculate future worth instead of present worth for comparing alternatives (less common, but say comparing what accumulates more in a fund). You can either convert everything to future at a common horizon using F factors, or to present using P factors. It yields the same decision as long as you use the same rate. So factor tables support both approaches; just pick one approach per problem to avoid confusion.

Special Notes – Calculator: With the factors identified, you'll mostly just do multiplication or division on your calculator. To avoid repetitive exponentiation, use the factor formulas intelligently. For instance, if you need P/A, you might compute $(1+i)^n$ once, then use it to get the factor instead of raising to power repeatedly. Many factors share components: e.g., once you have $(1+i)^n$ and maybe $(1+i)^n - 1$, you can get any of P/A, A/P, F/A, A/F easily. Also, consider storing intermediate results if doing many calculations at same i, n. If you're prone to hitting wrong buttons under stress, sometimes using the factor approach as a conceptual guide then plugging values carefully is safer than chaining a huge expression. For example, to compute $P = A * (P/A)$, maybe calculate the factor separately then multiply by A. It's one more step but reduces complexity in a single line of input.

Explanation: The interest factor tables essentially summarize *all the heavy lifting formulas* for time value of money. On the FE exam, they serve as a bridge between the wording of a problem and the calculation. When you see phrasing like "present worth of a series" or "annual payment equivalent," think in terms of these standard factors. It's a way of parsing the language: "present worth of series" → P/A; "annual equivalent of cost" → A/P; "sinking fund to reach X future sum" → A/F; "growth of a single deposit" → F/P, etc. Being comfortable with this shorthand means you don't have to re-derive logic each time.

Let's say a question asks: *"How much must be deposited each year into a fund paying 5% annual interest so that $10,000 will be available at the end of 10 years?"* If you know factor notation, you recognize this as A given F problem – specifically, find A such that $F = A(F/A, 5$. Solving for A: $A = F * (A/F, 5$. Now A/F is the sinking fund factor = $\frac{i}{(1+i)^n-1}$. You could plug values: $A = 10000 * \frac{0.05}{(1.05)^{10}-1}$. If you had a table, you'd look up (A/F,5%,10) and multiply by 10000. If not, you calculate as shown. The point is the table factor guided you to the right computation quickly.

As another example, *"Find the present worth of $2,000 per year for 8 years at 7%."* This is $P = 2000 * (P/A, 7$. Easy if you recall P/A or have it available. In absence, you derive or remember $P/A = \frac{(1.07)^8-1}{0.07(1.07)^8}$. It's doable but having the factor notion triggers the correct approach instantly.

The FE exam's reference will have those factor formulas grouped, so part of using "tables" on exam day is actually using that reference sheet effectively. Practice searching the PDF or flipping pages (if it were paper) for those factors. It might list them in a sequence – single payment factors, uniform series factors, gradient factors. Knowing that structure can save time.

Analysis: Consider how the factor table is structured logically: - The single payment factors (F/P and P/F) come from $F = P(1+i)^n$ and its inverse.

- The uniform series factors (P/A, A/P, F/A, A/F) come from summing geometric series or inverting those sums. They are interrelated: $A/P = 1/(P/A)$, $A/F = 1/(F/A)$. So really there are just two unique uniform series formulas and their reciprocals.

- The gradient factors (P/G, A/G, etc.) are derived from a series that's 0, A, 2A, ... or similar. They're a bit more complex but follow patterns too (involving terms like $(1+i)^n - 1$ and i and n).

- Each factor essentially encodes a small algebraic problem solution. By organizing them, the table lets you solve common problems in one step (lookup factor * multiply).

- From a usage perspective: these factors assume **end-of-period payments and one compounding per period equal to payment frequency**. We touched on this but to reinforce: if a problem doesn't fit that (like payments semiannual but interest annual, etc.), adjust before using a factor.

- One thing to emphasize: The factor notation $(X/Y, i, n)$ literally reads as "convert Y to X." For example, P/A = convert A (annuity) to P (present). A/F = convert F to A. This can help you double-check you picked the right one: if you want a present value from an annuity, P/A is correct. If you wanted an annual amount from a present, that's A/P. The order of the letters tells you what you get from what you have.

- A minor detail: sometimes textbooks put the interest rate as a subscript like $P/A\, i, n$ or as $(P/A, i$. They all mean the same; just be comfortable with the notation style. - When you apply a factor, you are essentially doing what our formulas in earlier subtopics do, but in one step. For instance, using P/A factor is doing a summation of discounted terms in one multiply. The factor tables are pre-solving that summation for you given i and n.

- In FE problems, if a factor is not directly available for weird values, rely on the formula. But for common interest rates like 5%, 8%, 10% and periods up to maybe 50, tables (in study materials) have these. If you had those memorized (not required though), it could speed up. However, I'd stress understanding over memorization – if you forget a factor, you can always derive it from basics quickly.

To conclude, using standard interest factor tables is about efficiency and accuracy. By recognizing the factor you need, you reduce the chance of using the wrong formula and you speed up the computation. On exam day, use the provided formulas as your "table." Practice a few problems with factor notation so that it becomes second nature to translate a word problem into something like "$P = A(P/A, i, n)$" before calculating. That little step of formalizing with factors can anchor your solution path and prevent mistakes.

Topic 02 - Cost Types and Breakdowns

Topic Introduction: In engineering projects and manufacturing, understanding different types of costs is crucial for decision-making. The FE Mechanical Exam often tests your grasp of cost classification and basic cost analysis. You might be asked to identify whether a given expense is fixed or variable, compute an average or incremental cost, or recognize the appropriate type of cost estimate to use in a project scenario. These questions are typically straightforward if you know the definitions and formulas—they're quick points on exam day once you have the concepts down. Cost breakdowns also tie into larger analyses like breakeven calculations and life-cycle costing, so mastering these fundamentals helps in more complex problems too.

Typical question scenarios include:

- Classifying a listed expense as **fixed vs. variable** or **direct vs. indirect**.
- Calculating an **average cost per unit** or an **incremental cost** given total costs at two production levels.
- Identifying a **sunk cost** that should be ignored in a decision.
- Recognizing what kind of **cost estimate (order-of-magnitude, budget, definitive)** is being described and its expected accuracy.

Understanding these cost types and breakdowns builds a foundation for tackling engineering economics problems efficiently. In this chapter, we'll break down each subtopic with clear definitions, formulas, and exam-focused insights.

K04.T02.S01 – Types of Costs: Fixed, Variable, Direct, Indirect, Capital, Operating

Principle Introduction – Cost Classification: Costs can be categorized in several complementary ways. Key classifications to know:

- **Fixed costs** – expenses that stay the same in total over a certain range of output or over a period of time (e.g. building rent or salaried management). These do not increase with production volume in the short term.

- **Variable costs** – expenses that change in proportion to production volume or usage (e.g. raw materials or hourly production labor). More output means higher total variable cost.

- **Direct costs** – costs that you can directly link to a particular product, project, or activity (e.g. parts and labor for a product line). These are typically variable with respect to that output.

- **Indirect costs** – costs that are not directly traceable to a single product or project, often shared across the organization (e.g. facility utilities, supervisor salaries). Also called *overhead*, these may be fixed or variable but are allocated indirectly.

- **Capital costs** – one-time expenditures for assets or project initiation (e.g. equipment purchase, installation, initial investment). Often incurred at the start of a project; also known as **capital expenditures (CAPEX)** or *first costs*.

- **Operating costs** – ongoing expenses to run and maintain a system or business (e.g. maintenance, fuel, utilities, labor). These recurring costs (often called **operations & maintenance (O&M)** costs) happen over the operating life and are sometimes termed **operational expenditures (OPEX)**.

Exam Handbook Search Cues (Not affiliated with or endorsed by NCEES): fixed cost; variable cost; direct labor; indirect cost; capital cost; operating cost (O&M)

Footnotes:

- *Fixed costs are typically constant only within a certain operating range or time period – extremely high production might eventually require new fixed investments.*

- *"Overhead" usually refers to indirect costs (like administrative expenses), but note that overhead can include both fixed components (e.g. rent) and variable components (e.g. utility bills that rise with usage).*

Variations and Related Concepts: Some costs have mixed behavior (semi-variable or **step costs**). For example, a utility might have a fixed monthly charge plus a variable rate for usage, or a new shift supervisor salary might kick in after a certain production threshold (making fixed cost jump in steps). The FE exam typically doesn't dive deep into these; it focuses on the clear-cut definitions above. Also remember that **total cost** often combines these types (see formula below), and context may link to other topics like **breakeven analysis** (which uses fixed vs. variable cost to find a no-profit point).

Explanation & Analysis: In cost analysis, we often express **total cost** as the sum of fixed and variable components. This breakdown helps to analyze how costs will behave as output changes.

Name & Purpose: *Total Cost Equation* – combines fixed and variable costs to give total expense.

$$C_{\text{total}} = C_f + c_v\, Q\,,$$

where this formula computes the total cost C_{total} for producing Q units, given a fixed cost C_f and a constant variable cost per unit c_v.

Variables and Units:

- C_{total} – total cost for the production period or batch (measured in currency, e.g. USD).
- C_f – total fixed cost over that period (currency units).
- c_v – variable cost **per unit** of product or output (currency per unit).
- Q – quantity of output or production volume (number of units).

Assumptions & Scope: This linear cost model assumes variable cost per unit c_v is constant, which is valid when unit costs don't change with scale (no bulk discounts or diminishing returns) within the range of Q considered. Fixed cost C_f is assumed truly fixed for that range (no additional fixed expenses kick in). These conditions typically hold in the short term or within a defined capacity.

Limit Checks (Sanity Tests): If $Q \to 0$, then $C_{\text{total}} \to C_f$. Even with zero output, you still incur the fixed cost – a good check on understanding fixed costs. If Q grows large, C_{total} grows without bound linearly (dominated by variable costs) – reminding us that fixed cost, though significant at low volumes, becomes relatively less important as output increases.

Use vs. Related Equations: Use this cost breakdown formula to compute total expenses or to plug into profit and breakeven calculations. In a **breakeven analysis**, for instance, you'd set total cost equal to total revenue to solve for the breakeven Q (using revenue = price × Q and cost as above). *Use this formula instead of averaging or incremental formulas when you need the absolute total cost for a given production level.* For per-unit cost or changes in cost, see the next subtopics on average and incremental cost.

Common Exam Pitfalls:

- **Forgetting the fixed cost at zero output:** A common mistake is to assume zero production means zero cost. Always remember to include fixed costs (they're incurred regardless of output).

- **Misclassifying costs:** Watch out for tricky wording in problems. For example, "electricity for factory lighting" might seem variable but is often a fixed monthly expense (doesn't strongly depend on production volume, especially if lights are on regardless). Conversely, "machine maintenance" might have both fixed (routine servicing) and variable (wear-and-tear per usage hour) components.

- **Direct vs Indirect confusion:** Direct costs directly tie to the product (if you stop making the product, you cut that cost). Indirect costs continue even if a specific product is dropped (unless you shut down entire facilities). On the exam, if asked to identify direct vs indirect, relate it to whether the cost would go away if the product or project did – if yes, it's direct; if no (it supports the company overall), it's indirect.

K04.T02.S02 – Incremental Cost, Average Cost, and Sunk Cost

Principle Introduction – Unit Costs & Irrelevant Costs: This subtopic deals with how costs scale and how past costs are treated:

- **Incremental cost** – the additional cost incurred by producing one more unit (or a certain additional batch) of product, or the cost difference between two alternatives. It's essentially the "cost of the next unit" and is central to deciding if an increase in output or a project expansion is worthwhile.

- **Average cost** – the unit cost, found by dividing the total cost by the quantity of units produced. This gives a measure of how much each unit costs on average and is useful for pricing and efficiency analysis. Average cost decreases as fixed costs are spread over more units (if fixed cost is present).

- **Sunk cost** – a cost that has already been incurred in the past and cannot be recovered. Sunk costs are *independent of any future actions* and should not influence current decisions. This concept often appears in questions to test if you know to **ignore sunk costs** when comparing alternatives.

Exam Handbook Search Cues (Not affiliated with or endorsed by NCEES): incremental cost; average cost; sunk cost

Footnotes:

- Incremental cost is sometimes used interchangeably with "marginal cost." In economics, marginal cost is the cost of the infinitesimally next unit (the derivative of cost with respect to quantity). For FE exam purposes, incremental and marginal cost concepts are equivalent for one additional unit.

- Sunk costs can also include prior investments or research expenditures. A classic pitfall is the "sunk cost fallacy," where people throw good money after bad because they feel they must justify past expenses – avoid this trap in engineering economics decisions.

Variations and Related Forms: If the cost per unit isn't constant, incremental cost might change with scale. For example, volume discounts could make the incremental cost for the 101st unit lower than the average cost of the first 100. But for most exam problems, either costs are linear (incremental cost equals the constant variable cost per unit) or you'll be given two total cost points and asked for the difference. Average cost is simply a ratio; sometimes it's broken into **average fixed cost** and **average variable cost** for deeper analysis (with average fixed cost = C_f/Q, which shrinks as Q grows). Sunk cost has no mathematical form since it's just identified and then ignored in calculations, but recognizing it is key (it might be given in a problem narrative to distract you).

Explanation & Analysis: To compute **average cost**, use the total cost breakdown from earlier and divide by Q. This yields:

Name & Purpose: *Average Cost Formula* – calculates the mean cost per unit of output.

$$C_{\text{avg}} = \frac{C_{\text{total}}}{Q},$$

which represents the average cost per unit at that production level. It combines fixed and variable costs averaged over each unit. For example, if total cost is \$1,000 for 100 units, the average cost is \$10/unit. If you increased to 200 units with total cost \$1,800, the new average cost is \$9/unit – lower, because the fixed cost is now spread over more units.

Variables and Units:

- C_{avg} – average cost per unit (currency per unit of output, e.g. USD/unit).
- C_{total} – total cost for the given output (currency).
- Q – number of units produced.

Assumptions & Scope: This formula is a direct definition – it's always true by how we define average. It assumes $Q > 0$ (you can't average cost over zero units; no production means the concept of average cost per unit breaks down). Average cost will change with Q if there are fixed costs or nonlinear variable costs. In the long run, average cost might approach the purely variable cost per unit if fixed costs become negligible per unit.

Limit Checks: Consider extremes: if $Q = 1$, then $C_{\text{avg}} = C_{\text{total}}$. One unit bears all the cost (including fixed). If Q is very large, C_{avg} will approach the variable cost per unit c_v (since $C_f/Q \to 0$). These limits make sense: producing extremely few units makes them very expensive each (because fixed cost looms large), while producing many units drives the average cost down near the variable cost baseline.

Use vs. Sibling Concepts: Use average cost when you need to report or compare cost efficiency per unit, or to determine pricing thresholds. For instance, if selling price per unit is below average cost, you're losing money per unit on average. **Use incremental cost instead of average cost when the question asks for the cost of *one additional unit* or the difference between two scenarios.** Incremental cost focuses on the change between levels, whereas

average cost is an overall snapshot per unit at a single level of output.

To find an **incremental cost**, you typically subtract the total cost at one production level from the total cost at a higher production level. If cost is linear: incremental cost for one extra unit = c_v (the variable cost per unit). In other cases:

$$\text{Incremental cost for going from } Q_1 \text{ to } Q_2 = C_{\text{total}}(Q_2) - C_{\text{total}}(Q_1).$$

If $Q_2 = Q_1 + 1$, this difference is the cost of one more unit. For example, if producing 10 units costs $500 and producing 11 units costs $540, the incremental cost of the 11th unit is $40.

Common Exam Pitfalls:

- **Mixing up average and incremental:** If a problem asks, "What is the cost to produce one additional unit?" do **not** give the average cost. Use the difference in total cost or the variable cost per unit. Conversely, if it asks for cost per unit overall, you need the average (including fixed portion), not just the per-unit variable cost.

- **Including fixed cost in incremental cost when not needed:** Often, fixed costs don't change with a small increase in Q. If you go from 100 to 101 units, the extra cost is typically just the variable cost for that unit (assuming you're within capacity). Don't wrongly allocate fixed cost again on the margin.

- **Counting sunk costs in decisions:** Exam questions might present a scenario like "$50,000 was spent on R&D last year, and now you can choose project A or B..." That $50,000 is sunk. The pitfall is to think one option is "down $50k" – but both options have that money spent regardless. Ignore it when comparing A vs B. Only consider future or incremental costs and benefits.

- **Forgetting units consistency:** Ensure when computing average cost that the total cost and quantity are for the same batch or time frame. If total cost is for a month's production and Q is the number of units that month, you're fine. But don't mix, say, annual cost with monthly production in the division.

K04.T02.S03 – Categories of Cost Estimates (Order-of-Magnitude, Budget, Definitive)

Principle Introduction – Estimating Accuracy: Engineers use different classes of cost estimates at various project stages. Each category of estimate has an expected accuracy range:

- **Order-of-Magnitude Estimate** – also known as a **conceptual** or **feasibility estimate**, made with very limited information (perhaps only a rough idea of the project scope). This is typically the first estimate for a project to check if an idea is in the right ballpark. It has the widest uncertainty range of all categories.

- **Budget Estimate** – an intermediate estimate prepared when some project design is developed (for example, ~20–40% of engineering design defined). It's used for budget approvals and planning. Accuracy is better than an order-of-magnitude but still has a noticeable margin of error.

- **Definitive Estimate** – also called a **detailed** or **control estimate**, made from completed or nearly completed plans/specifications. It's the most refined category and is used for final decisions, bids, and preparing final budgets. It has the tightest accuracy range (closest to actual costs).

Exam Handbook Search Cues (Not affiliated with or endorsed by NCEES): cost estimate accuracy; order-of-magnitude estimate; budget estimate; definitive estimate

Footnotes:

- Numeric accuracy ranges vary by source, but the exam expects you to know the rough magnitude of uncertainty for each category (very high for conceptual, moderate for budget, low for definitive). We provide typical values below – exact percentages aren't as important as the relative comparison.

- Some references break estimates into more classes (Class 1 through Class 5, as per AACE industry standards). For FE exam purposes, focusing on the conceptual vs preliminary vs detailed categories is sufficient.

Variations and Alternate Names: Order-of-magnitude estimates may also be called **ballpark estimates** or **Level 1 estimates**. Budget estimates might be termed **feasibility studies** or **preliminary estimates**. Definitive estimates are sometimes referred to as **engineer's estimates** or **bid estimates** (if used for contractor bidding). The idea of increasing accuracy with project definition is universal, even if terminology varies.

Explanation & Analysis: The table below summarizes the typical characteristics of these estimate categories, including how much project definition is available and typical accuracy ranges. Remember, the accuracy range is often given as "±X%" or as a low-high range (e.g. "-30% to +50%" meaning the estimate could be 30% lower or 50% higher than the actual final cost). The less information you have, the more uncertainty in the estimate.

Estimate Category	Project Definition Level	Typical Accuracy Range	Purpose
Order-of-Magnitude (Conceptual)	Very limited info (rough idea, 0–5% design complete)	**Approx. -50% to +100%** of actual cost (could be off by a factor of ~2)	Initial feasibility screening – "Is this idea even viable cost-wise?"
Budget (Preliminary)	Partial info (major aspects defined, ~20–50% design complete)	**Approx. -15% to +30%** of actual cost	Budgeting and interim project approval – "Can we fund this, and what's the likely cost range?"
Definitive (Detailed)	Full scope defined (>90% design complete, or based on vendor quotes)	**Approx. -5% to +10%** of actual cost	Final pricing, bids, and control – "What will it *actually* cost with known details?"

In practice, an **order-of-magnitude estimate** might be something like using a rule-of-thumb cost per square foot for a building to get a quick sense. It could easily end up double the final cost or half, since so many details are unknown. A **budget estimate** might come after some preliminary engineering: perhaps you have a rough layout and some equipment quotes, so the uncertainty narrows. A **definitive estimate** comes when you have detailed drawings, specifications, and firm supplier quotes – ideally your actual cost will fall within about ±10% of this estimate.

Common Exam Pitfalls:

- **Misidentifying the estimate type:** If a question says only a very rough scope was used to guess cost, don't call it a definitive estimate. Conversely, if near-complete plans were used, that's not an order-of-magnitude guess.

- **Forgetting which range is larger:** Order-of-magnitude has the largest uncertainty. It wouldn't be unusual to be off by half or double. If you see answer choices with ranges, pick the widest one for a conceptual estimate, and the narrowest one for a definitive estimate.

- **Over-precision:** Sometimes examinees think an estimate can be very precise early on – remember that high precision requires detailed information. The exam may test your intuition by giving a scenario of how much info is available and asking which accuracy to expect.

- **Confusing terminology:** Ensure you match the term to the correct stage. For example, don't confuse "budget estimate" with a project's budget itself. The budget estimate is just an estimate used to set a budget, not the final exact spending.

Topic 03 - Economic Analyses

Topic Introduction: *Economic analysis* tools help engineers evaluate the financial viability of projects and alternatives. On the **FE Mechanical Exam**, you'll face questions where you must decide if an investment "makes sense" financially: How many units must be sold to break even? Which project yields a better return? What is the **present worth** or **annual worth** of a series of cash flows? These problems are typically straightforward if you identify the correct formula or decision criterion. The key is to master core concepts like **break-even points**, **payback period**, **benefit-cost ratios**, **life-cycle costs**, **equivalent annual costs**, **present/future worth calculations**, **internal rate of return**, and accounting for **overhead**. Each concept is a tool for a specific archetype of question – know when and how to use them, and you'll navigate exam problems with confidence.

K04.T03.S01 – Breakeven Analysis & Simple Payback Period

Principle (at a glance):

- **Break-even point** is the level of output or usage at which total **revenue** equals total **cost**, resulting in zero profit. It's the "no gain, no loss" threshold for a project or product.
- Break-even analysis helps you find the value of a decision variable (such as production rate, operating hours, or selling price) at which competing options have the same total cost or profit.

- In manufacturing or business problems, break-even is often given in terms of units produced/sold or percentage of capacity. It tells you how much you must **produce** or **operate** to cover all **fixed** and **variable costs**.

- The **payback period** looks at time rather than units: it's the number of years (or months) needed for the running total of net cash inflows to catch up to the original outlay. Once cumulative cash flow turns non-negative, the project has 'paid itself back.

- Both break-even and simple payback are **quick screening tools**. They're easy to compute and give a rough sense of risk, but they **ignore the time value of money** (no discounting of future cash flows). On the exam, use them for basic viability checks, but remember their limitations.

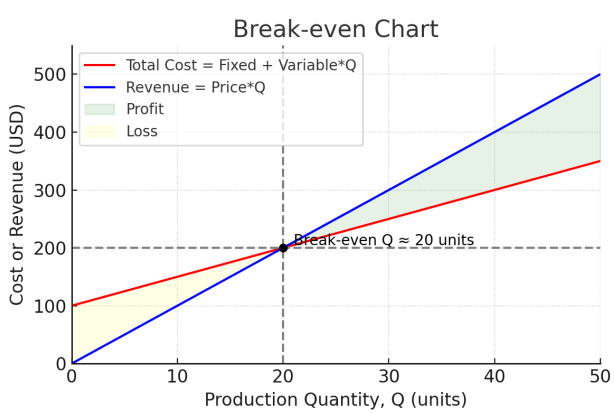

Break-even chart: A typical break-even graph for a product, showing the intersection of total cost and total revenue lines. The point where revenue equals total cost (here at Q ≈ 20 units) is the break-even point. At production quantities greater than this, the operation yields a profit; below it, it incurs a loss. The shorter line represents total cost = fixed + variable costs; the longer line is revenue from sales. The dashed lines illustrate that at **Q** = 20 units, revenue and cost are equal. This visual logic underpins the break-even formula derived below.

Exam Handbook Search Cues (Not affiliated with or endorsed by NCEES): *breakeven*, *break even*, *payback period*, *capacity*, *fixed cost*

Core Equation – Break-even Point (Production Quantity) – computes the output level needed to cover all costs (no profit, no loss):

$$Q_{\mathrm{BE}} = \frac{F}{p - v}$$

Where:

- Q_{BE} = break-even production **quantity** (in units of product, or hours of operation, etc.)
- F = **fixed costs** over the period (costs that do not depend on output, e.g. equipment, rent) [$]
- p = **selling price** per unit (revenue per unit sold) [$/unit]
- v = **variable cost** per unit (cost directly associated with producing one unit, e.g. materials, labor per unit) [$/unit]

Assumptions & Scope:

- Costs behave linearly: F is constant and v is constant per unit within the range of interest. We assume only one product (or one revenue stream) and a fixed unit price p. *In short, each unit sold contributes* $(p - v)$ *dollars toward offsetting fixed costs.*

- Break-even analysis is typically a **short-term** or single-period analysis (e.g. one year) and does not consider interest or time value. It addresses *"at what point will my sales cover my costs?"* without discounting.

- All units produced are sold (no inventory buildup) and the product's price and cost structure remain constant. If multiple products or changing prices are involved, a more complex or multi-variable break-even analysis is required.

Limit Checks (sanity tests):

- If fixed cost $F = 0$, then $Q_{\mathrm{BE}} = 0$. *No fixed cost means you're profitable from the first unit since there's nothing to "recover."*

- If the unit contribution margin $p - v = 0$ (price equals variable cost), then Q_{BE} would be infinite – you'd never break even because each unit barely pays for itself with nothing left to cover fixed costs. This highlights that a positive margin is required for any finite break-even point.

- As $p - v$ increases (cheaper production or higher price), Q_{BE} decreases, meaning you need fewer sales to cover the fixed cost. Conversely, a higher fixed cost F pushes the break-even quantity higher.

Using this vs. other analyses: Use the break-even formula for quick evaluations of a single-product scenario or comparing two options on a single factor. For instance, given two machines with different fixed and variable costs, find the production quantity where their total costs are equal – that Q is the break-even **indifference point**. *Do not* use this static formula if you need to account for **time value of money** or multi-year cash flows – in those cases, switch to a **present worth** or **NPV** analysis.

Common Exam Traps:

- **Unit confusion:** Make sure F and $p - v$ correspond to the same time frame. For example, if F is given per year, then $p - v$ should be the profit per unit *for that year's conditions*. If F is monthly, use monthly revenue minus cost per unit.

- **Rounding:** If you compute a break-even quantity that's not an integer, remember that you typically cannot sell a fraction of a unit. For a **break-even in units**, always round *up* to the next whole unit if the question asks "how many units to break even." Stating a non-integer value might be mathematically correct, but one more whole unit is needed to fully cover costs.

- **Forgetting the margin definition:** $p - v$ is often called the *contribution margin per unit*. Students sometimes mistakenly plug in total revenue or total variable cost instead of per-unit values. Make sure to use per-unit price and per-unit variable cost in the formula.

- **Ignoring context:** Break-even analysis can also be about finding a point in **time** (e.g. operating hours or years). In such cases, Q_{BE} might represent hours of operation required to cover costs, or years needed for savings to accumulate – conceptually the same idea. Ensure you interpret Q in the correct units as asked (units, hours, etc.).

Related Concept – Simple Payback Period: *Payback period measures how many years it takes before the running total of net cash inflows first reaches zero – i.e., the point where the project has recovered its upfront cost.* For a project with an initial cost C_0 and a constant annual net benefit A_{net} (profit or savings per year), the **simple payback** in years is:

$$t_{\text{payback}} = \frac{C_0}{A_{\text{net}}}$$

This formula assumes the net benefit A_{net} is the same each year. For example, if an energy-saving retrofit costs \$50,000 and yields \$10,000 per year in energy savings, the payback period is $50{,}000/10{,}000 = 5$ years. After 5 years, total savings (~\$50k) equal the initial cost.

Footnotes:

- *Payback vs. Break-even:* Payback period is literally the break-even point in time (years) for an investment. It's a **non-discounted** metric – it does **not** account for interest or inflation. The exam may ask for simple payback explicitly; just divide the initial cost by annual benefit (if benefits are uniform). A **discounted payback period** (which *does* account for time value) could be defined but is rarely used in FE-level problems unless specifically noted.

- *Interpreting payback:* A shorter payback period generally indicates less risk (you recover your money faster). However, neither payback nor break-even analysis considers what happens after the break-even point. A project with a long payback might still be very profitable in the long run, and one with a short payback could have limited life after payback. Always be cautious: these metrics ignore cash flows beyond the break-even point and the cost of capital.

- *Fixed vs. variable cost nuance:* In break-even problems, "fixed cost" can include overhead and other indirect costs that don't scale with output. Be prepared to include **overhead** in F if the problem statement mentions it (see subtopic S07 for overhead definition). Similarly, any cost that varies with output (materials, labor, utilities per unit) should be aggregated into v.

Explanation & Analysis: At its heart, the break-even formula comes from setting up the equality: **Total Revenue = Total Cost**. For a simple product sale scenario, that's $p \times Q = F + v \times Q$. Solving for Q gives $Q = F/(p - v)$. This tells us how many units Q are needed so that the revenue pQ covers the fixed cost F plus the variable cost vQ. Below that Q, revenue isn't enough and you operate at a loss; above it, revenue exceeds cost and you have a profit.

Let's break down each term: F is measured in dollars and is incurred regardless of output – think of it as the cost "baseline" you must overcome. Each unit you produce and sell brings in p dollars but also incurs an extra cost of v dollars. Thus, each unit contributes $p - v$ dollars toward covering that baseline F. The fraction $F/(p - v)$ essentially asks, "How many contributions of size $(p - v)$ are needed to sum up to F?" If F is large or if your per-unit margin $(p - v)$ is small, you'll need a lot of units to break even. If F is small or you have a healthy profit margin on each unit, the break-even quantity will be low.

For example, in the **break-even chart** above, fixed costs were set at \$100 (this is the y-intercept of the red cost line at Q=0). The product sells for \$10 each, and the variable cost is \$5 each. Every unit sold nets \$5 toward covering the \$100 fixed expense. By the formula, $Q_{\text{BE}} = 100/(10 - 5) = 20$ units. Indeed, at Q = 20, total cost = \$100 (fixed) + \$5×20 (variable) = \$200, and total revenue = \$10×20 = \$200. The lines cross exactly. If you sell 21 units, you'll have \$210 revenue against \$205 total cost, netting \$5 profit. If you sell only 10 units, revenue \$100 vs cost \$150 (100 fixed + 50 variable) leaves a \$50 loss. This linear break-even model is very common for quick estimates in both manufacturing and project budgeting.

The **payback period** extends this idea into the time domain. Instead of units, you're looking at **years** (or months) for cumulative cash flow to reach zero. The simplest case assumes a steady annual net cash inflow A_{net}. The reasoning: each year, you "earn back" some portion of your initial investment C_0. After t_{payback} years, you've earned back $t_{\text{payback}} \times A_{\text{net}}$, which we set equal to C_0. For instance, if $C_0 = \$50k$ and $A_{\text{net}} = \$10k/year$, after 5 years you have \$50k total, recouping the cost. If the exam question gives a series of cash flows rather than a constant annual amount, you would sum them year by year until the running total turns positive – that point where cumulative cash flow = 0 is the payback time.

In summary, break-even and payback are simple yet powerful for checking viability. Just remember: **they don't consider interest or what happens after breaking even.** On the FE exam, if a question asks for payback or break-even explicitly, stick to these formulas. But if a question hints at "which project is better financially" and gives multi-year cash flows or an interest rate, then a more comprehensive **NPV or IRR analysis** (see below) is needed instead of relying solely on payback or break-even.

K04.T03.S02 – Benefit–Cost Analysis (B/C Ratio)

Principle (at a glance):

- **Benefit–Cost Analysis** evaluates a project or investment by comparing the present value of all **benefits** (B) to the present value of all **costs** (C). It's often expressed as a **Benefit/Cost ratio (B/C)**. This is commonly used for public projects, infrastructure, or any scenario where you want to know if the overall benefits justify the expenses.

- The decision criterion is simple: if the benefits outweigh the costs, the project is acceptable. Quantitatively, practitioners often check whether the net benefit $B - C$ is non-negative. That condition is the same as requiring the benefit-cost ratio B/C to be at least 1. When $B/C = 1$, the project is exactly at the break-even point; values above 1 indicate more benefit per dollar of cost.

- A higher B/C ratio (>1) indicates a more efficient investment (more "bang for the buck"). For example, B/C = 1.5 means benefits are 1.5 times the costs. Conversely, B/C < 1 means the project's benefits don't cover its costs (likely a no-go).

- On the FE Exam, benefit–cost analysis questions typically involve summing up various benefits and costs (often given as lump sums or annual values) and then computing the ratio, or checking against 1. They may also present multiple projects each with a B/C ratio to ask which is preferable.

- **Important:** Benefits and costs must be evaluated on a **common monetary basis** (typically convert everything to present worth, or sometimes annual worth). In practice that means discounting future benefits and costs to present (or an equivalent annual amount) before forming the ratio. This ensures an "apples-to-apples" comparison of all cash flows.

Exam Handbook Search Cues (Not affiliated with or endorsed by NCEES): *benefit-cost*, *cost-benefit*, *B/C ratio*, *net benefit*

Benefit–Cost Ratio (Decision Equation) – compares the present worth of benefits to costs:

$$\text{B/C Ratio} = \frac{\text{Present Worth of Benefits } (B)}{\text{Present Worth of Costs } (C)}$$

The project is **acceptable if** $\frac{B}{C} \geq 1.0$. Equivalently, $B - C \geq 0$ indicates non-negative net benefit. In words: *"benefits equal or exceed costs."*

- B = Sum of all quantified **benefits** of the project, in present dollars (or equivalently in consistent currency units). Benefits can include revenues, cost savings, salvage value, environmental or social benefits converted to monetary terms, etc.
- C = Sum of all **costs** of the project, in present dollars. Costs include initial capital costs, operating and maintenance costs, replacements, and any negative impacts or disbenefits quantified in dollars.

Assumptions & Context:

- All significant benefits and costs have been identified and converted to monetary terms. Sometimes intangible benefits are hard to price (e.g. environmental improvement), but for exam problems you'll usually be given values or told what to include.

- The ratio uses **comparable time bases** for B and C. Typically, this means both are evaluated as present worths at a given discount rate (often the **MARR**, minimum acceptable rate of return, if provided). Alternatively, an annual worth basis could be used – as long as it's consistent. The exam problem should either provide an interest rate for discounting or imply that values are already present values.

- Benefit-cost analysis is often applied to **public sector or regulatory projects** where profit isn't the only measure—like evaluating a new highway, pollution control, or any project where you ask "do the overall benefits to society justify the cost?". However, it can equally apply to private investments (then benefits = revenues).

Decision Criteria Insights:

- If B/C > 1: Benefits outweigh costs → project is financially justified (in a pure economic sense).
- If B/C = 1: Benefits equal costs → project breaks even economically. In practice, decision might depend on other factors or considered marginal.
- If B/C < 1: Benefits are less than costs → project is not justified on economic grounds alone.

A **margin** above 1 is often desired to account for risk or uncertainty – a project that barely breaks even (B/C = 1.01) has little room for error. Exam questions might incorporate this by asking something like "which project has the highest B/C and should be selected, assuming all require B/C > 1 to be viable."

Common Exam Traps:

- **Mixing time frames:** Ensure that if some benefits or costs occur in the future, you discount them to present before taking the ratio. A frequent mistake is to take a simple ratio of undiscounted sums when an interest rate was given. Always use present (or annual) values consistently.

- **Forgetting certain terms:** Watch out for salvage values or one-time end-of-project costs; these should be counted. A salvage value is a benefit (it reduces net cost) – include it in B or subtract from C. For example, if a machine has a $5k salvage at end, that's $5k benefit to include.

- **Interpreting the ratio versus net benefit:** B/C ratio is useful, but it doesn't convey scale. Two projects could each have B/C = 1.2, but one might have $1,200 benefits over $1,000 costs (net $200) while another has $12,000 over $10,000 (net $2,000). If you must choose between mutually exclusive projects, the one with higher **net benefit (B - C)** could be the better choice, even if their ratios are equal. The exam might implicitly test this by giving options with similar ratios but different magnitudes. (In public projects, sometimes an *incremental benefit-cost analysis* is used to choose between alternatives – that's beyond our scope unless explicitly asked, but keep the concept in mind.)

- **Benefit vs. revenue:** In private investment problems, "benefits" usually mean revenues or savings. Ensure you identify what counts as benefit. For example, a cost *savings* (reducing expenses) is a benefit because it improves the cash flow. Likewise, avoid double-counting: if you include a particular cash flow as a benefit, it shouldn't also appear subtracting from costs, and vice versa.

Footnotes & Further Notes:

- In some formulations, especially for public projects, you might see **B/C** calculated as $\frac{B-C_{\text{non}}}{C}$ where C_{non} are "non-disbursement" costs (like user costs). Don't let that confuse you on the FE – generally stick to the basic ratio unless told otherwise.
- There is also a concept of **Profitability Index (PI)** in finance, which is essentially the B/C ratio for investments (often defined as $\frac{NPV_{\text{future cash flows}}}{InitialInvestment}$). It's conceptually similar: PI > 1 means positive NPV. If you encounter PI, it's analogous to B/C.

- **Cost-Benefit vs Benefit-Cost:** These terms are interchangeable; the exam might phrase it either way (cost-benefit analysis or benefit-cost ratio). It's the same concept, so don't get confused by wording.

Explanation & Analysis: Performing a benefit-cost analysis is straightforward: sum up the monetary value of all benefits, sum up all costs, and take the ratio. For example, suppose a city is considering a project with an upfront cost of $1,000,000 and expects to get $1,200,000 worth of societal benefits (in present value terms) from it – things like reduced travel time, accident reduction, etc. Here $B = \$1.2$ million and $C = \$1.0$ million. The B/C ratio = 1.2/1.0 = 1.2. Since it's > 1, the project is economically justified (20% more benefit than cost). If another project has B/C = 0.9, that one returns only 90 cents per $1 cost – likely not worth it.

In an exam setting, you might be given several cash flows. **Your first step should be to convert them to present values** (unless it's already given in present terms). For instance, say a project yields $50k benefit each year for 5 years and costs $40k each year to operate, with an interest rate of 5%. You'd find the present worth of benefits (an annuity of 50k for 5 years) and the present worth of costs (annuity of 40k for 5 years, plus perhaps any initial cost). Then compute the ratio. Don't forget any initial cost in year 0 – that would already be a present cost.

Mathematically, if i is the discount rate and all cash flows are converted to present worth: $B = \sum B_j/(1+i)^j$ and $C = \sum C_j/(1+i)^j$. The ratio B/C is dimensionless (both numerator and denominator are dollars). If i is not given, it might be implied that you can treat given amounts as comparable (perhaps all at present or just a qualitative comparison).

Finally, remember that benefit-cost analysis is usually about **independent** projects: we accept all projects with B/C ≥ 1. If the question is about choosing one project among options, and all have B/C ≥ 1, then the one with the highest B/C is economically the most efficient use of funds (assuming similar scope). But as noted, also be mindful of absolute net benefit if mentioned. In summary, for the FE exam: calculate B, calculate C, form the ratio, check against 1. It's a straightforward criterion, just be careful with the details of present worth and including all relevant terms.

K04.T03.S03 – Life-Cycle Costing (Including Operation & Maintenance Costs)

Principle (at a glance):

- **Life-Cycle Cost (LCC)** analysis tallies up all costs associated with an asset or project over its entire lifespan, from acquisition to disposal. Think of it as the total "cradle-to-grave" cost. This includes the initial purchase (or implementation) cost, plus all **operation and maintenance (O&M)** costs incurred year by year, plus any other recurring costs, and finally minus any **salvage value** (resale or residual value at end of life, which offsets cost) or plus disposal costs if any.

- The goal is to evaluate the *total cost of ownership* rather than just the upfront price. A classic example: a cheaper machine might have higher annual maintenance and energy costs, making its life-cycle cost higher than a pricier, more efficient machine. Life-cycle costing helps reveal such trade-offs by considering **all** costs over time.

- On the FE Exam, you might be asked to calculate the present worth of all these life-cycle costs or to compare alternatives on a life-cycle cost basis. For instance, "Given purchase price, annual operating cost, and salvage value of two different systems, which has the lower life-cycle cost over 10 years at 8% interest?" This means you'll sum up initial + present value of O&M + any other costs, minus present value of salvage, for each system.

- **Including O&M costs** is explicitly mentioned because often people forget ongoing costs. The exam will test that you know to incorporate things like yearly fuel, labor, or maintenance expenses into the economic evaluation, not just the sticker price.

- Life-cycle costing typically uses **discounted cash flow** analysis (time value of money) to bring all costs to a common time (usually present). However, if an interest rate isn't given, a problem might simply sum costs assuming equal value dollars (implicitly a 0% rate). Usually, though, expect to use a given interest or discount rate.

Life-cycle cost timeline: Illustration of costs over an asset's life. The horizontal line represents the timeline from year 0 (start) to year *n* (end of life). **First arrow (down)** at year 0 is the initial cost (money spent to acquire or start the project). **Middle arrows (down)** at years 1 through *n-1* represent ongoing annual O&M costs (operations, maintenance, etc., incurred each year). **Last arrow (up)** at the final year *n* represents the salvage value (money *received* at end-of-life, if any). In life-cycle cost analysis, all these cash flows are brought to present (or annual) equivalent values and summed to determine the total cost of owning the asset over *n* years.

Exam Handbook Search Cues (Not affiliated with or endorsed by NCEES): *life cycle cost*, *life-cycle analysis*, *operation and maintenance cost*, *O&M*, *total cost of ownership*, *salvage value*

Total Life-Cycle Cost (Present Worth Formula): To evaluate life-cycle cost, sum the present values of all costs and benefits over the life. If an asset has: C_0 = initial cost at $t = 0$; $A_{\text{O\&M}}$ = recurring annual O&M cost (assumed uniform each year for simplicity, from year 1 to n); and S_n = salvage value at end of life n; and using interest rate i for discounting, the *present worth of total cost* is:

$$P_{\text{LCC}} = C_0 \ + \ A_{\text{O\&M}} \cdot \frac{(1+i)^n - 1}{i(1+i)^n} \ - \ \frac{S_n}{(1+i)^n}.$$

Breaking this down:

- C_0 is already a present cost (no discounting needed since it's at time 0).
- The term $A_{\text{O\&M}} \cdot \frac{(1+i)^n - 1}{i(1+i)^n}$ is the **present worth of a uniform series** of annual O&M costs $A_{\text{O\&M}}$ over n years (this is the standard P/A factor formula). It converts all those future O&M expenditures into an equivalent lump sum at time 0.
- The last term $\frac{S_n}{(1+i)^n}$ is the present value of the salvage received in year n. We subtract it because salvage is a **benefit** (a negative cost): by selling or salvaging the asset at end of life, you recoup some money, effectively reducing the total cost. If there were a disposal cost instead of salvage gain, that term would be **added** as a cost.

Assumptions & Scope:

- We assume O&M costs are the same each year for the formula above. If O&M costs escalate or vary, you would discount each year's cost individually (or use a gradient series formula if it's a steady escalation). The FE exam typically provides either a constant annual cost or a list of yearly costs that you sum with discounting.

- The interest rate i used should reflect the effective discount rate for the project (could be given as a nominal with compounding or already effective per year). If no rate is given, either the problem expects a simple sum (no discounting) or it's incomplete. Usually, a rate is provided for economic analysis.

- Life-cycle costing is oriented toward **minimizing cost** (common in design decisions) rather than maximizing profit. Often, you'll compare the life-cycle costs of two alternatives (e.g., two machines with different efficiencies and lifespans) to decide which is more economical in the long run.

- All costs should be included: besides O&M, think of things like periodic major overhauls, installation costs, decommissioning costs, etc., if mentioned in the problem. The "life-cycle" means nothing is left out. In exam problems, any cost explicitly stated usually needs to be counted in either C_0 or as part of recurring costs, unless it's clear it's outside the analysis scope.

Common Exam Traps:

- **Forgetting salvage (or disposal):** Salvage value is easy to overlook. It can significantly affect the comparison between alternatives, especially if one has a much higher end-of-life value. Always check the problem: if an asset has a resale value at the end of use, convert that to present value and subtract it out of the cost.

- **Misplacing costs on the timeline:** Ensure you put costs in the correct year for discounting. Initial costs C_0 at time 0 are not discounted. Costs at the end of each year for n years use the annuity formula as above. A cost at the very end of year n (like decommissioning cost or salvage received) is one period farther out than the last O&M if O&M was counted from year 1 to $n - 1$. Just be careful in distinguishing "end of year n" versus "through year n". The formula above assumed O&M from 1 through n, and salvage at end of year n – which is typical.

- **Ignoring interest if provided:** Life-cycle cost should account for the time value of money. If the exam gives an interest rate or MARR (minimum attractive rate of return), you *must* use it to discount future costs. Adding up undiscounted costs over years and comparing to an alternative that has different timing can lead you astray.

- **Unequal lifespans:** If you are asked to compare options with different lifespans on a life-cycle cost basis, strictly speaking you should compare them over a common time horizon. A common technique is using **equivalent annual cost** (next subtopic) or assuming repeatability of shorter-life assets to match the longer-life horizon. The FE exam may simplify this by giving equal lengths or by explicitly asking for *annual* cost comparison. But be mindful: you can't directly compare a 5-year cost to a 10-year cost without adjustment.

- **Omitting categories of cost:** Don't focus only on initial vs. operating. Sometimes fuel, electricity, labor, maintenance, insurance, etc., are all part of O&M. If the problem statement lists multiple ongoing expenses, include them all (sum them up as an annual total).

Footnotes:

- *Optimal economic life:* Life-cycle costing also underpins finding the **optimal life** of an asset. For example, equipment might have increasing maintenance costs as it ages. There's often a sweet spot year to replace it that minimizes the total annual cost. Though not always explicitly tested, the idea is to calculate life-cycle cost for different lifetimes and find which gives the lowest equivalent annual cost. If you see a question like "how long should we keep this machine?", it's using life-cycle thinking (minimizing the sum of ownership and operating costs per year).

- *Total Cost of Ownership:* This is another term for life-cycle cost, often used in procurement and project management. It reminds you to consider everything from installation to operation to disposal. On the exam, if they mention "total cost over X years" or "life-cycle cost," they expect you to account for all those phases.

- *Inflation:* Most FE exam problems treat costs in **constant dollars** (no inflation) unless stated otherwise. If a problem did mention an inflation rate separate from discount rate, a more complex calculation using a real interest rate would be needed (e.g., using $d = i - f$ approximately, or $d = \frac{1+i}{1+f} - 1$). This is likely beyond what they'll ask in a straightforward manner, but just remember: "including O&M costs" means current estimates; if inflation isn't mentioned, assume costs stay effectively the same in real terms each year.

Explanation & Analysis: Life-cycle cost analysis essentially adds up *everything you're going to spend* on a project and accounts for *when* you spend it. By discounting future costs back to present, you can compare them fairly with costs today. For example, consider a heating system for a building: Option A costs \$5,000 to install and \$500 per year to run; Option B costs \$8,000 to install but only \$200 per year to run, both with a 10-year life and no salvage, at 5% interest. Which is cheaper long-term?

For Option A:

- Initial $C_0 = \$5{,}000$.
- Annual O&M = \$500. Present worth of 10 years of \$500 = $500 * \frac{(1.05)^{10}-1}{0.05(1.05)^{10}}$ (using the P/A factor). If we compute that factor, it is about 7.72, so that's \$500 * 7.72 ≈ \$3,860.
- No salvage, so total $P_{\text{LCC,A}} \approx \$5{,}000 + \$3{,}860 = \$8{,}860$.

For Option B:

- Initial $C_0 = \$8{,}000$.
- Annual O&M = \$200. Present worth of 10 years of \$200 = $200 * 7.72 \approx \$1{,}544$.
- No salvage, so total $P_{\text{LCC,B}} \approx \$8{,}000 + \$1{,}544 = \$9{,}544$.

Even though B was more efficient yearly, the higher upfront cost doesn't quite pay off over 10 years in present value terms – Option A has the lower life-cycle cost in this scenario (assuming a 10-year horizon). If the horizon were longer or energy costs were higher, the result could flip. Life-cycle analysis allows such comparisons.

The above calculation shows the mechanics: convert each series of costs to present, add them. If salvage were included, say Option B had a \$1000 salvage at year 10, we'd subtract its present value (~\$613 at 5%) from B's total, getting \$8,931 – still a bit higher than A.

On the FE exam, you might not need to show all steps if you can do factor calculations quickly, but it's wise to write out the components: "Present worth = initial + (annual cost * factor) - (salvage * factor)." This keeps everything clear and earns partial credit in case of a minor arithmetic slip (for paper exams) or at least guides your thinking in computer-based questions. Also, be vigilant for any *non-annual* costs: e.g. a major overhaul in year 5 – discount that single amount too (that would be $\frac{\text{overhaul cost}}{(1+i)^5}$ added to the sum).

In summary, life-cycle costing is about completeness: include **all** relevant costs over time and convert them to a common basis. It provides a holistic view of cost effectiveness and is often the foundation for computing metrics like **equivalent annual cost**, which we'll turn to next.

K04.T03.S04 – Equivalent Annual Cost (EAC) for Alternatives

Principle (at a glance):

- **Equivalent Annual Cost (EAC)**, also known as **Annual Worth**, is the uniform annual cost (or net cash outflow) of owning and operating an asset, calculated such that it is economically equivalent to the actual (possibly uneven) cash flow stream of that asset. In simpler terms, it's the amount you'd pay each year that would equal the same total present cost.

- EAC is extremely useful for comparing alternatives with different lifespans or cost patterns on an equal footing. By converting everything to a per-year cost, you can see which option costs less per year on average. The one with the lower EAC is the more economical choice over the long run (assuming both meet the required performance).

- On the FE exam, typical problems include selecting equipment or projects where one may have a higher initial cost but longer life, and another has lower cost but shorter life. Calculating EAC for each allows a fair comparison without arbitrarily extending or truncating lifespans.
- To compute EAC, you usually start with the **present worth of all costs** (which we found in subtopic S03 as P_{LCC}) and then convert that present worth into an equivalent annuity over the asset's life. This uses the **capital recovery factor**. Alternatively, you can convert each component (initial cost, annual costs, salvage) into their annual equivalents directly. The result is a cost per year figure.

- **Important:** When comparing alternatives with different lives, EAC analysis effectively assumes that each option could be repeated with similar cost patterns so a meaningful 'per-year' comparison can be made. In practice, you compute EAC over one life cycle of each alternative and compare the resulting annual costs. Practically, you compute EAC for one life cycle of each alternative. If one lasts 5 years and another 7 years, you compute each's EAC (per year cost) – that inherently accounts for their different life spans via the formula. The alternative with lower EAC delivers the same service at lower cost per year.

Exam Handbook Search Cues (Not affiliated with or endorsed by NCEES): *equivalent annual worth*, *annual cost*, *capital recovery*, *A/P factor*, *annual worth analysis*

Key Formula – Convert Present Worth to Equivalent Annual Cost: If an asset has total present worth of cost P_{LCC} (including initial, O&M, minus salvage as computed prior) over n years at interest rate i, its EAC is given by multiplying by the **capital recovery factor** $(A/P, i, n)$:

$$EAC = P_{\text{LCC}} \times \frac{i(1+i)^n}{(1+i)^n - 1}.$$

This formula essentially spreads out the present cost P_{LCC} into n equal annual installments (covering both recovery of the capital and interest on the unrecovered balance, akin to a loan payment). It's sometimes broken into parts for clarity:

- **Capital Recovery portion:** $C_0 \times \frac{i(1+i)^n}{(1+i)^n-1} - S_n \times \frac{i}{(1+i)^n-1}$. This part converts the initial cost and salvage into an annual net cost. C_0 is converted into an annuity (like paying off C_0 over n years), and S_n is converted into an annual equivalent credit (since salvage reduces overall cost).
- **Plus annual O&M:** If there's a uniform annual O&M cost $A_{\text{O\&M}}$, that simply adds on: $A_{\text{O\&M}}$ (since it's already an annual cost).

So you might also see EAC expressed as:

$$EAC = C_0(A/P, i, n) + A_{\text{O\&M}} - S_n(A/F, i, n),$$

which is exactly the same result. Here $(A/F, i, n)$ is the factor to convert a future amount (salvage) to an equivalent annual series (numerically $A/F = \frac{i}{(1+i)^n-1}$).

- $C_0(A/P, i, n)$ is the annual cost to recover the initial cost C_0.
- $S_n(A/F, i, n)$ is the annual *savings* equivalent to receiving S_n at the end (this will be a smaller annual number that, if saved each year, grows to S_n in the end – subtracting it means we pay less per year thanks to the salvage value).
- $A_{\text{O\&M}}$ is added as-is (assuming it's constant each year). If O&M is not uniform, you'd convert those costs to an equivalent uniform amount as well, but usually the exam will give a steady yearly cost for simplicity or have you

combine multiple yearly costs into one average annual cost if needed.

Assumptions & Scope:
- The interest rate i is the same as used in life-cycle costing; it reflects the cost of capital or MARR. EAC inherently accounts for that by including interest in the annualized figure.
- We assume the pattern of costs repeats if we consider a longer horizon than one life. In other words, if we compare a 5-year machine vs a 10-year machine, computing EAC for each effectively assumes that after 5 years the first machine would be replaced with another similar machine (incurring those same costs again) to serve for 10 years total. EAC is a way to compare without manually doing the repeat cycle – it's built into the math.
- All costs are accounted for, as with life-cycle costing. EAC is just a different expression of the same cash flow set. If an alternative doesn't have a salvage (or it's negligible), the salvage term drops out. If an alternative has non-annual expenses (like an overhaul every 3 years), you would either incorporate that into P_{LCC} and then annualize, or convert that series into an equivalent annual amount directly. Either approach yields the same EAC.
- One thing EAC assumes is that the scale of operation is the same between alternatives. That is, we're comparing costs to perform the same task. EAC wouldn't be appropriate if the alternatives had different output or capacity (you'd have to normalize or adjust for output first). On the exam, alternatives are usually just two ways to fulfill the same requirement.

When to Use EAC:

- When comparing projects or equipment with unequal lives. For example, should you buy Truck A (cheaper but shorter life) or Truck B (expensive but lasts longer)? Compute each's EAC over its life; the lower EAC indicates which truck costs less per year to own and operate.

- When a question specifically asks for "equivalent uniform annual cost" or "annual worth" of an option. This is a cue to use the formulas above to convert lump sums into an annual value.

- EAC is also used in **lease vs. buy** decisions or any scenario where you want to express the total cost as a yearly amount for budgeting.

Common Exam Traps:

- **Using the wrong factor (P/A instead of A/P, etc.):** It's easy to confuse which way to convert. Remember: to go from present to annual, use A/P. To go from future (salvage) to annual, use A/F. A quick check: A/P has dimension [1/year] essentially – multiplying a present value by A/P yields a yearly amount. P/A is year, and would be used if you had an annual amount and wanted a present value. Keep the perspective straight: here we have total present cost and want an annual cost → $A = P \cdot (A/P)$.

- **Forgetting salvage or treating it incorrectly:** If there is a salvage value, it *lowers* the EAC, because it's a benefit at the end. You either subtract the salvage's annual equivalent (as in the formula above) or equivalently subtract the salvage's present value before converting to annual. A mistake would be to add salvage as if it were a cost, or to ignore it. For example, a high salvage can significantly offset the annual cost – don't miss it.

- **Not rounding properly:** Occasionally, an EAC might come out to, say, \$10,432.67 per year. On the exam, if answers are multiple-choice, they might round to \$10.4k or \$10.43k. Make sure you carry enough precision through calculations (especially with the $(1+i)^n - 1$ in the denominator) to not introduce rounding error. It's often safest to compute the factor fully in your calculator then multiply by P.

- **Mixing up cost and revenue scenarios:** EAC can also be used for net **annual worth**, where you include revenues minus costs and get a net annual profit. In that case, a positive annual worth indicates a profitable project. But if the problem is framed as cost minimization, just stick to costs. If an alternative has revenue, you might incorporate it as negative cost (or an equivalent annual revenue subtracted from cost). Just keep signs clear: costs positive in the formulas, salvage a negative cost, revenues could be treated like negative costs as well.

Footnotes:

- The term **EUAC** (Equivalent Uniform Annual Cost) is synonymous with EAC. Sometimes you'll see **EUAW** (Equivalent Uniform Annual Worth) if including both costs and revenues. They all boil down to converting cash flows to a constant annual amount.

- If comparing alternatives, ensure they accomplish the same goal for the comparison to be valid. If alternatives have different outputs, you may need to normalize (e.g., cost per unit output per year). The FE exam usually sidesteps this by giving clearly comparable options.

- Calculators: The allowed FE exam calculators don't have a specific EAC button, but you can always do it step by step. Calculate $(1+i)^n$, then the factor $i(1+i)^n/((1+i)^n - 1)$. It might be easier to use the reciprocal form: $A/P = \frac{i(1+i)^n}{(1+i)^n - 1}$. For example, if i = 0.08, n = 5: first compute $(1.08)^5 - 1$, then divide that into $0.08 * (1.08^5)$. Careful use of parentheses will get you there. Some students prefer computing P/A (the annuity present worth factor) and then taking its reciprocal for A/P. Either way works as long as you're careful.

Explanation & Analysis: Let's illustrate EAC with a concrete example. Suppose we have two machines: Machine X: costs \$10,000 now, \$1,000 annual operating cost, 5-year life, no salvage. Machine Y: costs \$15,000 now, \$600 annual operating cost, 8-year life, \$3,000 salvage at end. Which is cheaper in terms of **annual cost**? Assume an interest rate of 7%.

First, compute present worth of costs for each:

- **Machine X:** $P_X = 10{,}000 + 1{,}000 * (P/A, 7$ salvage. The P/A factor for 5 yrs at 7% is, say, approximately 4.100 (we can calculate precisely but let's estimate). Then $1{,}000 * 4.100 = \$4{,}100$. So $P_X \approx 10{,}000 + 4{,}100 = \$14{,}100$.
- Convert to EAC: $A_X = 14{,}100 * (A/P, 7$. Now $A/P, 7$ is the reciprocal of 4.100, or we calculate $A/P = \frac{0.07(1.07)^5}{(1.07)^5 - 1}$. That factor comes out to roughly 0.2439 (per year). Multiply: $A_X \approx 14{,}100 * 0.2439 = \$3{,}437$ per year. So Machine X effectively costs about \$3,437 each year.

- **Machine Y:** $P_Y = 15{,}000 + 600 * (P/A, 7$. The P/A for 8 yrs at 7% might be about 5.971, so $600 * 5.971 = \$3{,}583$. The salvage present value $3{,}000/(1.718) \approx \$1{,}746$ (since $1.07^8 \approx 1.718$). So $P_Y \approx 15{,}000 + 3{,}583 - 1{,}746 = \$16{,}837$.
- Now $A_Y = 16{,}837 * (A/P, 7$. The A/P for 8 yrs is the reciprocal of 5.971, around 0.1674. So $A_Y \approx 16{,}837 * 0.1674 = \$2{,}817$ per year.

Comparing: Machine X ~ \$3,437/yr, Machine Y ~ \$2,817/yr. Even though Y costs more initially, its better efficiency and salvage yield a lower annual cost. So Y is the economical choice over the long term.

This example demonstrates how EAC accounts for differences in life and salvage: we effectively "leveled" each machine's cost to a yearly charge. Notice the 8-year machine's cost is spread over more years and it has salvage credit, bringing its annual burden down.

On an exam, you could be directly asked for the EAC of one option, or to decide between options using EAC. Always include **initial, O&M, and salvage** in your calculations. If the problem gives you costs in different time frames (like a big overhaul in year 5), you can either fold it into the present worth then annualize, or convert that overhaul into an equivalent yearly cost by itself. For instance, a \$5,000 overhaul every 5 years could be treated as an annual cost of $5000 * (A/P, i, 5)$ spread over each 5-year cycle – but it's safer to stick with present worth then to annual.

Finally, EAC isn't only for costs. If needed, you could compute an **equivalent annual *benefit*** or net profit in the same way. It's just the mirror image (with revenues positive, costs negative). But for "economic analyses" on the FE, EAC is mostly used for cost comparison. Master the formula and concept, and you'll handle those questions with ease.

K04.T03.S05 – Present Worth and Future Worth Analyses (Discounted Cash Flows)

Principle (at a glance):

- **Present Worth Analysis** (PW) and **Future Worth Analysis** (FW) are fundamental techniques based on the **time value of money**. They allow you to convert a series of cash flows occurring at different times into a single equivalent amount at a single point in time – either at the present (time 0) or at some future time. This makes it possible to compare cash flows or investments by their overall value.

- Essentially, **money now is worth more than money later** (assuming a positive interest rate), and these methods account for that. We do this by *discounting* future cash flows to the present (for PW) or *compounding* present/series values to a future date (for FW). They are two sides of the same coin: if you find the present worth of a cash flow series, you can always multiply by $(1+i)^n$ to get the future worth at year n; conversely, a future worth can be discounted back to present by $1/(1+i)^n$.

- On the FE Exam, you'll see problems asking for the **net present value** of a project (which is just present worth of benefits minus present worth of costs), or asking "how much will this investment be worth in X years" (future worth). You may also need to utilize standard cash flow patterns like **uniform series** or **gradient series** to compute present or future values efficiently using formulas or factors.

- **Uniform series** (equal payments each period) have special formulas for present and future worth, which are provided in the Exam Handbook and are good to remember. For example, paying \$A each year for n years is equivalent to some lump sum P now (that formula involves $(1+i)^n - 1$, etc.). We've actually used these in previous sections: they are the P/A and F/A factors.

- **Gradient series** (cash flows that increase by a constant amount each period) also have formulas, but these are less commonly needed unless a gradient is explicitly described (like maintenance costs rising by \$100 each year). The linear gradient formula was in the Handbook, but if needed, one can always compute year by year. Uniform series are far more common.

In summary, present and future worth analysis let you reduce a complex timeline of money to one number at a reference point, making decisions and comparisons much easier.

Exam Handbook Search Cues (Not affiliated with or endorsed by NCEES): *present worth factor*, *future value*, *uniform series*, *P/A factor*, *F/A*, *discounted cash flow*, *net present value (NPV)*

Key Formulas for Discounted Cash Flows: The fundamental relationship for compounding and discounting is:

$$F = P(1+i)^n,$$

which means a present amount P grows to a future amount F in n periods at interest rate i per period. Equivalently, $P = F/(1+i)^n$.

For a **uniform series** of amount A each period (1 through n), the formulas are:

- *Present Worth of a Uniform Series:*

$$P = A\frac{(1+i)^n - 1}{i(1+i)^n},$$

which is often called the P/A factor. This gives the equivalent present value P at time 0 of receiving (or paying) \$A each period for n periods (starting at end of period 1).

- *Future Worth of a Uniform Series:*

$$F = A\frac{(1+i)^n - 1}{i},$$

which is the F/A factor, yielding the equivalent amount at the end of period n of those series of payments A. (It's basically P from above grown to n: $F = P(1+i)^n$.)

If you compare these formulas, you see $F = P(1+i)^n$ holds, as it should.

For completeness, *if you're given P and need an equivalent uniform A (like capital recovery), the formula is $A = P\frac{i(1+i)^n}{(1+i)^n-1}$ – which we used in the EAC section.* Also, *given F to find uniform A, $A = F\frac{i}{(1+i)^n-1}$*. These are just rearrangements, sometimes called A/P and A/F factors.

- *Present Worth of a Linear Gradient:* (payments that increase by a constant amount each period, starting from 0 at end of year 0). The formula (for completeness) is $P = G\frac{(1+i)^n - in - 1}{i^2(1+i)^n}$, where G is the annual increment. And *Future Worth of Gradient:* $F = G\frac{(1+i)^n - in - 1}{i^2}$. These are less likely to be needed unless you have a specific gradient scenario, but they exist. If needed, one can always calculate gradient cases manually year by year, since n is usually not large on exam problems.

Assumptions & Scope:

- All these formulas assume **discrete compounding** at rate i per period (period typically = 1 year on the exam, unless stated otherwise). They also assume payments occur at the end of each

period (end-of-year convention). If you had beginning-of-period payments (annuities due), slight modifications (like multiplying by $1 + i$) are needed, but that's rare in FE exam questions unless explicitly mentioned.

- The interest rate i is constant over the periods considered. If the rate changes, you'd have to break the timeline into segments. The exam will usually give a single effective rate to use or assume one implicitly (like "at 8% interest" or using MARR as the discount rate).

- The cash flows are known and deterministic (no risk factored; uncertainty is a separate consideration). Discounted cash flow analysis presumes we're just dealing with time value and not probabilistic cash flows (except maybe expected value in decision trees, but that's another topic).

- **Present worth analysis** often underpins the calculation of **NPV (Net Present Value)**. NPV is just present worth of benefits minus present worth of costs. If NPV >= 0 at the MARR, the project is acceptable (this ties in with IRR and B/C criteria as well). Similarly, **future worth** could compare alternatives by the amount of money each yields at a common future point given all inflows and outflows.

Using PW/FW vs other methods:

- Use present worth or future worth when you find it easier or when the problem specifically asks for "present value" or "future value." They are particularly straightforward for a single project's viability or for ranking projects if scale is not an issue.

- Sometimes, present worth is easier when dealing with costs and revenues directly; future worth might be conceptually simpler if the question asks "how much will you have at the end if you invest...," etc. They are equivalent evaluations; you can do either as long as you compare projects on the same time basis.

- Do not mix present and future values arbitrarily: if comparing two projects, either compare their present worths (at the same point in time, usually time 0) or their future worths at a common future year. If lives differ, you might find a common future horizon or use EAC as noted.

Common Exam Traps:

- **Incorrectly handling timing:** The most common mistake is plugging n or the cash flows in wrong by one period. For example, if there's an initial cost at time 0, that is already a present amount and doesn't get discounted. If there's a series of payments starting at year 1 through 5, that's a standard annuity (n=5 in the formula). But if a series is from year 2 through 6, that's effectively an annuity deferred one year – you could compute present worth at year 1 then discount one more year. Always draw a quick timeline if unsure.

- **Using the wrong formula variant:** e.g., mistakenly using the P/A formula when you needed P/F for a single future sum. If you only have one future sum, use $P = F/(1+i)^n$. P/A is for a series of equal amounts. Similarly, students sometimes confuse the factors or try to memorize blindly. It helps to derive them conceptually: *"If I get A each year, it's like A*(some factor) = P." *If you forget the formula, you can derive it by summing a geometric series:* $P = A[1/(1+i) + 1/(1+i)^2 + \ldots + 1/(1+i)^n]$. *That sum equals the given P/A formula. In a pinch, you could compute that sum manually for small n.*

- **Forgetting that revenue and cost signs matter:** Present worth of costs might be summed and subtracted from present worth of benefits. If a question asks for NPV, it might give a mix of incoming and outgoing cash flows. Keep track of signs: for instance, if you have an initial cost (negative cash flow) and then positive returns each year, your present worth = - (initial cost) + PV of returns. A careless error is to add everything as positive.

- **Rounding intermediate steps:** Using factors from the handbook tables is convenient but they might be rounded. If high precision is needed (usually not too high for exam), be mindful. But generally, using 4-5 decimal places factor or doing full calculator computation yields a sufficiently accurate answer.

- **Non-annual compounding:** If interest is not annual (say semi-annual compounding), adjust i and n accordingly. For example, 8% compounded quarterly for 2 years: use $\mathrm{i} = 0.08/4 = 0.02$ and $\mathrm{n} = 2 * 4 = 8$ quarters in formulas. The exam may test this in a straightforward way like "what is the future value after 2 years with X compounding periods." The formula $\mathrm{F} = \mathrm{P}\left(1 + \frac{\mathrm{r}}{\mathrm{m}}\right)^{\mathrm{mt}}$ is essentially the same as the basic formula with adjusted i and n. Just remember to apply that if needed (the handbook lists "Non-Annual Compounding" formulas as well).

Footnotes:

- Some problems might involve **continuous compounding** (though more common in financial math than FE). If it does, the formula becomes $F = Pe^{rt}$. But unless explicitly stated, assume discrete compounding.

- **Effective vs Nominal interest:** The FE might drop a concept question like "effective annual interest rate" given a nominal. If you see nominal rate r with m compounding periods, effective $i_{\text{eff}} = (1 + r/m)^m - 1$. But for most cash flow calculations, they'll either give you an effective rate to directly use per period or enough info to deduce it.

- **Partial periods:** If a cash flow happens in months or days, you might have to adjust n to that fraction. But usually, exam questions keep to yearly or whole period increments. If something like "6 months" pops up with an annual rate, use $n = 0.5$ years in $(1+i)^{0.5}$ etc., or better use formula $F = P(1+i)^t$ with t in years which can be fractional.

Explanation & Analysis: Present and future worth analysis are straightforward applications of compound interest theory. To use them effectively, a systematic approach helps: **(1)** lay out the timeline of cash flows; **(2)** pick a reference point (present or future) to which to convert all flows; **(3)** apply the appropriate formula for each flow or series of flows; **(4)** sum them up.

For example, suppose a project requires an initial investment of \$5,000 now, will yield \$1,500 at the end of each of the next 4 years, and then have a final salvage of \$500 at end of year 4. If the interest rate is 6%, what is the project's NPV (present worth)?

Timeline: at t=0: -\$5,000; t=1: +\$1,500; t=2: +\$1,500; t=3: +\$1,500; t=4: +\$1,500 + \$500. We discount each of these to t=0:

- PV of initial cost = -\$5,000 (already at present).
- PV of the annuity of \$1,500 for 4 years = $1{,}500 * \frac{(1.06)^4 - 1}{0.06(1.06)^4}$.
- Using the P/A factor for 6% and 4 years, $(P/A, 6\%, 4) \approx 3.465$.
  So PV of the annuity $\approx \$1{,}500 \times 3.465 \approx \$5{,}198$.
  PV of salvage $\$500$ at $\mathrm{t} = 4$ is $500/1.06^4 \approx \$396$.

Sum: NPV $\approx -5{,}000 + 5{,}198 + 396 \approx \$594$ (positive, so the project earns about $600 more than the required 6% break-even level in present-value terms).

- PV of salvage $500 at t=4 = $500/(1.06)^4 \approx 500/1.2625 \approx \$396.0$.

Using $(P/A, 6\%, 4) \approx 3.465$, the present worth of the $1,500 /year series is

$$PW_{\text{annuity}} \approx 1500 \times 3.465 \approx \$5{,}198.$$

The present worth of the $500 salvage is

$$PW_{\text{salvage}} = \frac{500}{(1.06)^4} \approx \$397.$$

So

$$NPV \approx -5{,}000 + 5{,}198 + 397 \approx \$595.$$

The project is economically acceptable, providing about $600 of present value above the break-even point at 6%.

We could also compute the future worth of the project at the end of year 4 ; this must give the same economic decision as the present-worth analysis. At year 4 , the initial $-\$5{,}000$ has grown to

$$-\$5{,}000(1.06)^4 \approx -\$6{,}312.$$

The $1,500 per year series accumulates to year 4 using the uniform-series factor:

$$F_{\text{annuity}} = 1{,}500(F/A, 6\%, 4) \approx 1{,}500 \times 4.375 \approx \$6{,}562.$$

The salvage value is $500 at year 4 . So the net future worth at year 4 is

$$FW \approx -6{,}312 + 6{,}562 + 500 \approx \$750.$$

Discounting this back 4 years at 6% using the single-payment factor gives

$$PW = 750(P/F, 6\%, 4) = \frac{750}{(1.06)^4} \approx \$594,$$

which matches the net present value we found earlier (small differences are just rounding).

In the exam, you might directly get: "Compute the present worth of …" or "What is the future value of …". Or sometimes an investment question: "If you invest $$X$ now and $$Y$ in 3 years, how much will you have in 5 years at Z% interest?" – that's future worth with multiple deposits (just compute growth for each deposit separately and add up).

Uniform series formula usage is a big time-saver. Instead of summing each payment, use P/A or F/A factors. The Exam Handbook provides those formulas (and factor tables for certain interest rates). You can use either formula or table lookup if the exact interest and period are tabulated. But be cautious: if you use a table, ensure you pick the right columns and multiply correctly.

Lastly, always double-check if the problem is asking for *present* or *future*. If it asks "how much will it be worth in the future," give a future amount. If it asks "what is it worth now," give present value. Net present value (NPV) specifically means present. If they say "determine the equivalent worth in year 10 of …," they want a future value at year 10. It's all about moving money to one point. Practicing these conversions until you're comfortable is worthwhile—fortunately, they follow directly from that one core formula $F = P(1+i)^n$.

K04.T03.S06 – Internal Rate of Return (IRR) and Minimum Attractive Rate of Return (MARR)

Principle (at a glance):

- **Internal Rate of Return (IRR)** is the interest rate at which an investment's net present value (NPV) equals zero. In other words, it's the discount rate that makes the present worth of all cash inflows equal to the present worth of all cash outflows. Equivalently, it's the rate of growth a project is expected to generate. If you think of a project's cash flows like a loan or an investment, IRR is the effective interest rate you're getting on that transaction.

- **Minimum Attractive Rate of Return (MARR)** (sometimes "Minimum Acceptable Rate of Return") is a threshold rate set by an investor or a company – the *lowest* return that they consider worthwhile for an investment given its risk and the opportunity cost of capital. It's basically the hurdle rate or cutoff. If a project's IRR is below the MARR, the project is rejected; if IRR is above or equal to MARR, the project is potentially acceptable (at least from a return standpoint).
- In the FE exam context, you won't likely be solving IRR with long trial-and-error (which can be tedious). Instead, expect conceptual questions about IRR and decision rules, or simple cash flow setups where the IRR can be determined by inspection or a simple calculation. For instance, a single investment and single payoff, or two years of flows, which you can solve with a quadratic or a quick guess.

- The **decision criterion** using IRR: *Accept the project if* **IRR ≥ MARR**; *reject if* **IRR < MARR**. This ensures that the project earns at least the minimum required return. If IRR = MARR exactly, it's right on the threshold (often essentially a break-even in return sense).

- IRR is popular because it gives a percentage return figure, which is intuitively easy to compare to the required rate or other investment returns. However, it has some pitfalls (multiple IRRs in weird cases, assumes reinvestment at IRR, etc.), but those are beyond the basics typically needed for FE – except maybe a conceptual twist question.

Exam Handbook Search Cues (Not affiliated with or endorsed by NCEES): *rate of return*, *internal rate*, *IRR*, *MARR*, *minimum acceptable rate*, *investment yield*

Definition/Note Passport: Internal Rate of Return (IRR) – The IRR is the interest rate at which the **NPV = 0** for a series of cash flows. It's found by solving:

$$\sum_{j=0}^{n} \frac{CF_j}{(1+\text{IRR})^j} = 0,$$

where CF_j are the cash flows at time j (with outflows as negative, inflows as positive). In practical terms, if you discount all cash flows at the IRR, the investment's costs and benefits exactly balance out.

- **Where it matters (exam impact):** IRR appears in questions about project selection. For example, you might be given multiple projects with their IRRs and the company's MARR, and you have to decide which are acceptable. Alternatively, a question might give simple cash flows and ask to compute IRR (often for one-period or two-period cases where algebra is simple). Understanding that IRR is the "break-even" interest rate for a project's viability is key.
- **Pitfall or confusion point:** Don't confuse IRR with the actual dollar profits or with growth rates of individual cash flows. It's a weighted rate for the whole project. Also, note that having a high IRR doesn't always mean a project is better in absolute terms – scale matters (a small project with IRR 30% might yield less net money than a huge project with IRR 15%). But if projects are independent, generally higher IRR is good as long as it's above MARR.
- **Micro-check:** *True or False:* If a project's IRR is greater than the company's MARR, the project's NPV (at MARR) will be positive. **(True.)** When IRR > MARR, discounting at MARR (a lower rate) would yield NPV > 0, meaning the project makes more than required. If IRR < MARR, NPV at MARR is negative (not meeting required return).

Relationship to MARR: The MARR is basically a benchmark. It might be given explicitly, or you might infer it from context (like "the company uses 10% as its discount rate for evaluations" essentially means MARR = 10%). On the exam, a typical prompt: "The project's IRR is 12%. If the firm's minimum attractive rate of return is 15%, what is the investment decision?" Answer: reject (because 12% < 15%).

Common Exam Scenarios:

- **Calculate IRR for a simple cash flow:** e.g., "Invest $1000 now, get $1210 one year later. What's the IRR?" Here you solve $-1000 + 1210/(1 + IRR)^1 = 0$ which gives $1 + IRR = 1210/1000 = 1.21$, so IRR = 21%. These straightforward cases are fair game.

- **Identify IRR vs MARR decision:** e.g., "Project A: IRR = 8%. Project B: IRR = 12%. MARR = 10%. Which project(s) are acceptable?" → Project B is acceptable (12% > 10%), A is not (8% < 10%). If they're mutually exclusive, you'd pick B.

- **Conceptual understanding:** maybe a question like "What does an IRR actually represent?" or "When IRR equals the discount rate, what is the project's NPV?" (Answer: zero). Or "What if a project has two IRRs – when can that happen?" (Answer: non-normal cash flows with multiple sign changes; though unlikely to be asked, but they might test if you know IRR isn't always unique).

- They may also test understanding that IRR is independent of external rates – it's calculated solely from the cash flows themselves.

Common Exam Traps:

- **Solving IRR incorrectly:** If you have multiple years, you may need to use trial and error or interpolation. Students might plug in MARR mistakenly or confuse IRR with simple averages. If asked to compute IRR, set up the NPV equation properly = 0. For a two-year project: $-C_0 + C_1/(1 + r) + C_2/(1 + r)^2 = 0$. Solve for r. If guessing, test an r that makes the positive and negative parts equal. The exam might allow a bit of guesswork if answer choices are far apart.

- **Using IRR for mutually exclusive projects:** Technically, choosing solely by IRR can be misleading if projects differ in scale. The exam might avoid this nuance or include a net present value comparison instead. But remember, the highest IRR doesn't always yield the highest total NPV unless the scale is similar. However, if asked without caveat, assume independent project acceptance by IRR is fine.

- **Confusing IRR with interest earned on interim cash flows:** The IRR calculation inherently assumes that any intermediate cash flows are reinvested at the IRR. That's a theoretical point – in reality, you might reinvest at a different rate. But for exam purposes, just stick with the definition. If anything, they might throw a conceptual question like "Which method assumes reinvestment at the MARR?" (Answer: NPV method implicitly assumes reinvestment at MARR; IRR method assumes reinvestment at IRR – one of the reasons NPV is considered more realistic if IRR is very high). That level of detail is rare but possible in a conceptual question.

Footnotes:

- *Multiple IRRs:* If a project's cash flow changes sign more than once (e.g., an outflow, then inflows, then another big outflow), the NPV = 0 equation can yield multiple mathematically valid IRRs. This is beyond FE exam depth typically, but if it ever came up, know that normal projects (one outflow then inflows) have a unique IRR.

- *No IRR scenario:* In some cases, no real IRR exists (if NPV never crosses zero). Also rare to discuss on FE, but just for completeness: e.g., all positive cash flows (no investment) has no IRR solution.

- *IRR vs ROI:* Sometimes people use "ROI" loosely. In accounting, ROI might be a different calculation (like average annual profit divided by initial cost). Don't mix that up with IRR, which is a specific time-value-based rate. The FE exam will specifically say IRR or give context that clearly means IRR.

- *Solving tip:* If you do need to find IRR by trial on a simple problem, remember that NPV is a decreasing function of the discount rate (higher discount rate → lower NPV for a given set of cash flows, since future money is worth less). So if your trial at 0% gives a positive NPV (just sum of flows), and at a very high rate it gives negative NPV, the IRR is somewhere in between. You can hone in by interpolation if needed.

Explanation & Analysis: IRR essentially measures the yield of a project. Let's say you have a project with cash flows: invest $100 now, get $120 back in a year. As shown, IRR = 20% because 100 growing at 20% becomes 120. If the company's MARR was 15%, this project's IRR (20%) exceeds it, so it's a go – it's earning more than the minimum required.

For a longer example, consider: invest $1000 now, get $600 in year 1 and $600 in year 2. What's IRR? We solve $-1000 + 600/(1 + r)^1 + 600/(1 + r)^2 = 0$.

For a longer example, consider: invest $1,000 now, get $600 in year 1 and $600 in year 2 . What's IRR?

We solve $-1000 + \frac{600}{1+r} + \frac{600}{(1+r)^2} = 0$.

Multiply both sides by $(1+r)^2$:

$$-1000(1+r)^2 + 600(1+r) + 600 = 0.$$

Expanding and simplifying gives $10r^2 + 14r - 2 = 0$.

Solving the quadratic,

$$r = \frac{-14 \pm \sqrt{196+80}}{20} = \frac{-14 \pm \sqrt{276}}{20}.$$

The positive root is approximately $r \approx 0.131$, i.e. IRR $\approx 13.1\%$.

You can check this by trial:

- "At 10% : NPV $= -1000 + 600/1.10 + 600/1.10^2 \approx +40.5$ (positive)."
- "At 15% : NPV ≈ -24.6 (negative).

Therefore, the IRR is between 10% and 15%, and more careful trial or the quadratic solution gives about 13%.

So, you invest 1000, you get 1200total back $(600 + 600)$ – clearly that is more money back than put in, IRR should be > 0. Actually, check the NPV at 0%: $-1000 + 600 + 600 = +200$, so IRR should be positive. Our quadratic solving might have sign errors. Let's do it a simpler way by trial: try 20%: NPV $= -1000 + \frac{600}{1.2} + \frac{600}{1.2^2} = -1000 + 500 + 416.7 = -83.3$(negative NPV at 20%). Try 10%: NPV $= -1000 + \frac{600}{1.1} + \frac{600}{1.1^2} = -1000 + 545.5 + 495.9 = +41.3$(positive NPV at 10%). So IRR is between 10%and 20%. Try 15%: NPV $= -1000 + \frac{600}{1.15} + \frac{600}{1.15^2} = -1000 + 521.7 + 453.5 = -24.8$(still slightly negative). Try 14%: NPV $= -1000 + \frac{600}{1.14} + \frac{600}{1.14^2} \approx -1000 + 526.3 + 461.7 = -12.0$. Try 13%: NPV $= -1000 + \frac{600}{1.13} + \frac{600}{1.13^2} \approx -1000 + 531.0 + 469.0 = 0.0$(almost exactly). So IRR $\sim 13\%$.

So the project's IRR is ~13%. If MARR was, say, 10%, the project is good (IRR 13 > 10). If MARR is 15%, not good (13 < 15). This manual search demonstrates what IRR means: the NPV went from positive at 10% to negative at 15%, crossing zero in between at the IRR.

For the FE exam, you won't have to do such heavy trial-and-error because either choices will allow approximation or the setup is simpler. The key takeaway: IRR is the breakeven rate. It ties together with other measures: if IRR >= MARR, then NPV (at MARR) >= 0, which aligns with the benefit-cost ratio >= 1 as well (since NPV >=0 means benefits minus costs >=0 when discounted at MARR). They're all consistent.

Remember, **MARR is a criterion, IRR is a characteristic of the project**. The exam might give you IRR directly, or you might compute it, but always compare to MARR (or whatever the required return is called in the problem) for decision-making. If no MARR is given and you're asked to "compute IRR," just do that and interpret it as the answer (likely as a percentage). And if asked which project to pick and given IRRs, pick the one with IRR above MARR (or the highest IRR if multiple above MARR and only one can be done, though strictly speaking should do incremental analysis – but FE probably expects highest IRR if scale isn't discussed).

K04.T03.S07 – Economic Analysis of Overhead

Principle (at a glance):

- **Overhead costs** represent the ongoing expenses of operating a business or project that are not directly tied to a specific product or activity output. These include things like rent, utilities, administrative salaries, insurance, and depreciation of facilities – generally, costs that keep the lights on and the organization running. In engineering economic analysis, overhead is typically treated as a **fixed cost** that must be accounted for when evaluating project economics or unit costs.

- From a project perspective, overhead can be seen as the portion of costs that *don't* change with the level of production in the short term, but still need to be paid for. For instance, whether a factory produces 100 units or 1,000 units, it pays the same monthly rent for the building – that rent is overhead.

- On the FE Exam, overhead may come into play in problems involving **cost estimation, break-even analysis, or manufacturing cost per unit**. You might be given direct costs (labor, materials) and an overhead rate to apply. Or you might be told the fixed overhead for a period and need to include it in total cost or break-even calculations. Recognizing overhead ensures you don't underestimate total costs.

- **Overhead allocation:** Often overhead is allocated to products or projects based on some driver (like labor hours, machine hours, or direct costs). For example, a common approach is to have an "overhead rate" such as 50% of direct labor cost – meaning for every $1 of direct labor, add $0.50 as overhead. This doesn't change the economics, it just distributes the overhead to units to get unit cost. In break-even terms, overhead usually appears as part of total fixed cost F. In project selection, overhead can affect the cost base that needs to be covered by project revenue.

Exam Handbook Search Cues (Not affiliated with or endorsed by NCEES): *overhead cost*, *indirect cost*, *fixed cost*, *burden*

Definition/Note Passport: Overhead (Indirect Cost) – Overhead means the continuing operating costs of a business that aren't directly tied to producing a product or delivering a service. These costs are "indirect" because while they are necessary for operations, they cannot be conveniently traced to a specific unit of output.

- **Where it matters (exam impact):** Overhead matters in **cost analysis and break-even problems**. If a problem provides overhead costs or an overhead rate, it expects you to include those in the total cost. For instance, if the manufacturing overhead is $100,000 per year, that $100k is a fixed cost that must be covered in the break-even calculation (add it to F). If overhead is given as a percentage (say "factory overhead is 20% of direct labor cost"), you need to apply that to find the total cost per unit or total cost.
- **Pitfall or confusion point:** A common confusion is to think of overhead as profit or to ignore it altogether. They are *costs*, not profit. Another point: overhead is usually time-related (per month or year). If you're computing per-unit cost, you have to spread the overhead over the number of units produced. If production volume changes, the *per unit* overhead allocation changes (lower volume -> higher overhead cost per unit). This can affect pricing and break-even.
- **Micro-check:** Suppose a plant has $1,000,000/year in overhead costs and produces 50,000 units/year. How

much overhead cost is embedded in each unit? **Answer:** $20 per unit. (This is the overhead allocation per unit at that production level.)

Integration in Economic Analysis:

- In **break-even analysis**, overhead is part of fixed costs that must be recovered. For example, if you have $200k/year in overhead and $50k in other fixed costs, your total $F = \$250k$. You then divide by the contribution margin to get break-even quantity.

- In **project costing**, overhead needs to be included to get the true project cost. If a project uses a lot of company resources, a portion of overhead should be assigned to it (some exam problems may simplify this by directly giving total cost including overhead, or they explicitly instruct to add overhead via a rate).

- In **make-or-buy decisions or cost estimates**, overhead allocation can tip the scales. Sometimes a product seems cheap on direct costs, but once overhead is allocated, it's actually more expensive than buying from outside. Exam questions might implicitly test this understanding by giving you both direct and indirect costs.

Common Exam Traps:

- **Ignoring overhead when given:** If a problem states an overhead cost or rate, don't treat it as fluff. It's there to be used. For instance, if you're asked for cost per unit and they mention overhead, add it in. If overhead is 100k/year and you project making 10k units, overhead contributes $10/unit to cost. Forgetting it would understate cost.

- **Applying percentage to wrong base:** If given "overhead is 30% of direct labor cost," and direct labor per unit is $50, then overhead per unit is $15 (not $0.30). Or if total direct labor is $100k, overhead is $30k. Ensure you multiply correctly (and not divide or something silly). Also make sure you apply it to the correct cost element. Sometimes overhead is given as a percent of labor, or percent of total direct cost. Read carefully.

- **Misclassifying costs:** Sometimes exam questions list various costs and ask which are variable, which are fixed, etc. Recognize overhead items (like supervisor salary, building rent) as fixed/indirect. In break-even or cost behavior terms: overhead typically doesn't vary with production in the short run, so it's fixed. Some overhead might step up if capacity increases (like needing a second shift supervisor after a certain point), but those complexities usually aren't in FE scope.

- **Double counting:** If a total cost already includes overhead, don't add it again. For instance, "The unit cost including overhead is $5" – then overhead is already factored in. But if it says "Unit direct cost is $4, overhead is 25% of direct cost," then total unit cost = $4 + 25%*4 = $5.

Footnotes:

- Overhead is sometimes split into categories: e.g., **Manufacturing Overhead** (factory-related like maintenance, depreciation, factory management) vs. **SG&A** (selling, general & admin) which might be considered overhead for the company but not tied to manufacturing. In production cost questions, "overhead" usually refers to manufacturing overhead. Unless the problem delves into those distinctions, treat overhead as one lump fixed cost category.

- The term **"burden"** is sometimes used for overhead allocation (especially in phrases like "burden rate"). It's essentially the same concept – the extra cost loaded onto direct costs to cover indirect expenses. So if you see "burden" in a problem statement, interpret it as overhead.

- In engineering firms or service industries, overhead might be applied as a percentage on labor or as a fixed monthly charge. The FE exam, however, will likely give you straightforward numbers or percentages to include.

Explanation & Analysis: To cement understanding, let's consider an example. Imagine you run a machine shop that builds custom parts. You have the following yearly costs: $50,000 in rent, $20,000 in utilities, $80,000 for a supervisor's salary, and $150,000 in direct materials and labor for actually making parts. Here, the rent, utilities, supervisor – totaling $150,000 – are **overhead** (indirect, largely fixed costs to keep the shop open). The $150,000 direct materials and labor are **direct, variable costs** (they scale with how many parts you make).

Now, if you produce 1000 parts a year, the direct cost per part is $150,000/1000 = $150. The overhead per part, allocated, is $150,000/1000 = $150 as well. So the total cost per part is $300. If you priced below $300, you'd lose money because you wouldn't cover overhead. Many businesses mistakenly price at just above direct cost, thinking they're making profit, but if they neglect overhead, they're actually losing money overall. On the exam, a break-even problem might incorporate this by saying: variable cost per unit $150, annual fixed (overhead) cost $150k, price $300 – find break-even quantity. You'd do $Q_{BE} = F/(p - v) = 150000/(300 - 150) = 1000$ units. That aligns with covering $150 overhead per unit.

Another scenario: You're given an overhead rate: say overhead = 200% of direct labor. If direct labor for a job is $2,000, overhead to allocate = $4,000. So total cost = direct labor $2k + overhead $4k + any other direct costs. This could appear in a question about project cost estimation or manufacturing cost. Always apply the overhead rate to the specified base (in this case, labor). The reason companies use such rates is to distribute overhead proportionally to labor hours or cost, under the assumption that more labor-intensive jobs consume more overhead resources (like more supervision, more facility usage). It's an accounting approach, but for FE, just treat it as a multiplier to add costs.

From a **decision-making** viewpoint, overhead is a sunk or fixed cost in the short term. When making short-term decisions (like "should we accept a special order at a discounted price?"), one might ignore overhead if it won't change and just ensure the price covers variable cost. However, in long-term or break-even analysis, you absolutely must cover overhead through revenue. The exam may not get into these nuanced scenarios explicitly, but understanding when overhead matters is useful: for break-even and long-term viability, include overhead; for incremental decisions with idle capacity, overhead that doesn't change might not factor into the incremental cost (unless the problem explicitly wants full cost analysis).

Finally, overhead can be reduced or spread out by increasing volume – which lowers the cost per unit (economies of scale). But increasing volume might require more overhead eventually (like needing a bigger factory). Such strategic considerations are beyond exam scope, but they form the backdrop of why overhead analysis is important: it's the difference between profit and loss at the end of the day. For FE preparation, just remember: **include overhead in cost calculations as instructed, treat it as fixed for break-even, and allocate it properly if asked.**

DON'T MOVE ON YET!

Work Through Some Solid Practice Problems
while the Material of this Knowledge Is Still Fresh
THIS IS HOW THE CONCEPTS LOCK IN.

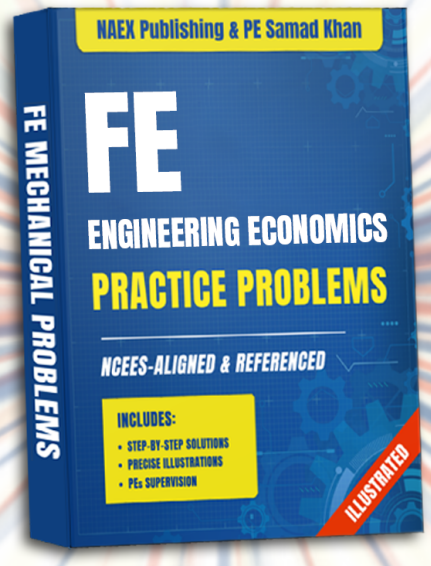

CLICK HERE TO PRACTICE

You'll be taken to our Discord Server, where the problems are located.

KNOWLEDGE 05

ELECTRICITY AND MAGNETISM

- NAEX Publishing -

"This publication is not affiliated with or endorsed by NCEES".

Topic 01 - Electrical Fundamentals

Topic Introduction: Electrical fundamentals cover the core concepts and quantities that describe electric circuits and electromagnetic effects. Even in the FE Mechanical Exam, you will encounter basic electrical and magnetism questions – for example, calculating the current drawn by a device, the power dissipated in a resistor, or understanding how a capacitor stores energy. Mastering this topic ensures you can confidently handle those few but vital electrical questions on exam day. Typical question archetypes include straightforward circuit calculations using Ohm's law, unit conversions for electrical quantities, and recognizing how energy is stored or dissipated in circuit components. In other words, this topic gives you the essential "electric toolkit" to solve simple circuit problems that a mechanical engineer should know.

K05.T01.S01 – Basic Electrical Units and Quantities

Principle Introduction: The building blocks of any electrical problem are a handful of fundamental quantities and their units. These define how we measure electric charge, how current flows, how voltage drives that current, how resistance impedes it, and how power quantifies energy transfer. Understanding these terms is the first step in analyzing circuits or electromagnetic systems:

- **Charge (Q):** The amount of electric charge represents the quantity of electricity. It is measured in **coulombs (C)**. One coulomb is the charge of approximately 6.242×10^{18} electrons. In formula terms, charge is what accumulates when current flows (e.g. $Q = I \times t$ for a steady current I over time t). Charge can be positive or negative, and like mass in mechanics, it is a conserved quantity – it cannot be created or destroyed, only transferred.
- **Current (I):** Electric current describes how quickly electric charge passes a point. It is measured in amperes (A), and one ampere equals one coulomb of charge moving past that point each second (1 A = 1 C/s). If you picture electric charge as water, current is analogous to the flow rate. A higher current means more charge is moving each second. Current direction is defined as the direction positive charges would flow (conventional current).
- **Voltage (V):** Voltage is the electric potential difference between two points, measured in **volts (V)**. One volt is defined as one joule of energy per coulomb of charge (1 V = 1 J/C). In practical terms, voltage is the "pressure" pushing electric charges through a circuit. If current is the flow of water, voltage is like the pressure difference driving the flow. A higher voltage means each coulomb of charge carries more energy.
- **Resistance (R):** Resistance is how much a material or component resists the flow of electric current, and it is measured in **ohms (Ω)**. One ohm equals one volt per ampere (1 Ω = 1 V/A). A large resistance means that a given voltage will drive a small current. Physically, resistance converts electrical energy into heat (this is what happens in a resistor). Every real conductor has some resistance (except ideal superconductors), and resistors are circuit elements designed to have a specific resistance value.
- **Power (P):** Electric power is the rate of electrical energy transfer or conversion, measured in **watts (W)**. One watt equals one joule per second (1 W = 1 J/s). In circuits, power can be calculated as the product of voltage and current (P = V·I). For example, if a 9 V battery drives a 2 A current through a circuit, it is delivering $P = 9\text{ V} \times 2\text{ A} = 18\text{ W}$ of power. Power can be absorbed by components (e.g. a resistor converting electrical energy to heat) or delivered by sources (e.g. a battery or power supply providing energy).

Exam Handbook Search Cues (Not affiliated with or endorsed by NCEES): *coulomb; ampere; volt; ohm; watt; charge; current; voltage; resistance; power*

Footnotes:

- In electrical formulas, the symbol Q denotes electric charge (do not confuse this with Q used for heat in thermodynamics). Likewise, P here denotes power (not to be confused with pressure P in fluids or mechanical power in horsepower). Always rely on context: in the FE Electrical Fundamentals, P will almost always mean electrical power in watts.

- The SI base unit for current is the ampere (A), which is a fundamental unit. Other electrical units are derived: for instance, 1 coulomb is defined as 1 ampere-second (C = A·s), and 1 ohm is 1 volt per ampere. Keep unit consistency in calculations to avoid errors (e.g. convert mA to A by dividing by 1000).

Variations and Related Forms:

- Unit equivalences: 1 volt = 1 joule/coulomb (energy per charge), 1 ohm = 1 volt/ampere (voltage per current), and $1\ watt = 1\ joule/second = 1\ volt \cdot ampere$. Knowing these can help sanity-check answers. For example, if you compute a quantity in V·A, you can recognize it as power in watts.

- Sometimes you'll hear *voltage* referred to as **electric potential** or **EMF (electromotive force)** in older terminology. They all relate to the same concept (potential difference in volts). Similarly, electrical *current I* might be called amperage, and electric *charge Q* might be referred to in terms of number of electrons or coulombs. The exam will stick to the standard terms (volt, ampere, coulomb, etc.), but it helps to recognize synonyms.

Explanation & Analysis: These fundamental quantities are interrelated in every circuit. Think of a simple analogy: imagine electricity flowing like water in a pipe. **Charge** is analogous to the amount of water. **Current** is like the flow rate of water – how much water passes per second. **Voltage** is comparable to the pressure difference pushing the water through the pipe. **Resistance** is like a restriction or narrow section in the pipe that resists flow – higher resistance means less water flows for a given pressure. And **power** is the rate at which work is done or energy is transferred by the flow – analogous to the hydraulic power delivered by the water flow (pressure × flow rate). Using this analogy, Ohm's law (coming up next) is akin to saying *flow rate = pressure / resistance*. In any FE exam problem, when you identify these quantities, first check their units and meaning: Is the current given in A or in mA? Is the voltage provided as a difference or an absolute level? By grounding yourself in the definitions of Q, I, V, R, and P, you set up a correct solution path. Remember that these basics underlie more complex

electrical concepts, so a firm grasp here will pay off in understanding circuits, energy storage, and magnetism in the rest of this topic.

K05.T01.S02 – Ohm's Law and Electrical Power

Principle Introduction: Ohm's Law is the cornerstone relationship in electric circuits, tying together voltage, current, and resistance for any ohmic (linear) conductor. It tells us how much current flows through a resistor for a given voltage. Building on that, the power relationship $P = VI$ tells us how much energy per second is being used or produced in the circuit. On exam day, problems in this area are typically straightforward: you'll solve for one variable given the other two (for example, find current given a voltage and resistance), or compute power dissipated in a resistor. These formulas also combine with each other – for instance, you might compute current via Ohm's law, then plug into $P = VI$ to find power. Because they are so fundamental, it's easy to overlook unit details or misapply them, so a clear "passport" for these equations helps ensure you use them correctly under exam pressure.

Equation Passport: Ohm's Law and Electrical Power

- **Name and Purpose: Ohm's Law** – relates the voltage drop across a resistor to the current through it and its resistance. **Electrical Power formula** – computes the rate of energy dissipation (or supply) in an electrical element from voltage and current. Use Ohm's Law to find an unknown V, I, or R in a simple circuit, and use the power formula to find how much power is dissipated by a resistor or delivered by a source.

- **Equation:**

$$V = I\,R,$$
$$P = V\,I = I^2\,R = \frac{V^2}{R}.$$

Variables and Units:

- V – voltage (potential difference across the element), in **volts (V)**.
- I – electric current through the element, in **amperes (A)**.
- R – resistance of the element, in **ohms (Ω)**.
- P – electric power (energy per time) associated with the element, in **watts (W)**.

Assumptions and Scope:

- Ohm's Law $V = IR$ assumes a *linear* resistor or resistance. It holds for metal conductors and resistors that obey a linear relationship between V and I (constant R). It does **not** apply to non-linear components (for example, a diode or a light bulb filament at varying temperature) except at a given operating point as a tangent. On the FE exam, most circuit elements are ideal and ohmic unless stated otherwise.
- These formulas are for **steady-state or DC conditions**. In AC circuits, $V = IR$ applies to the resistive parts of the circuit (using RMS values typically), but more generally one would use impedance for inductors or capacitors (beyond the scope of this subtopic). The power formula $P = VI$ gives *instantaneous* power at any moment. For constant DC, that's just a constant value. For AC, true power delivered to a load would be $P = VI\cos\phi$ (with $\cos\phi$ the power factor) – but if the exam expects that, it will be under AC analysis topics. **For our DC fundamentals, simply use $P = VI$.**
- Units must be consistent: use volts in V, amperes in I, ohms in R. If you plug V in volts and I in amperes, the calculated P comes out in watts automatically. Any prefixes (kilo, milli) should be converted as needed. The relationships $P = I^2R = V^2/R$ are derived by combining $P = VI$ with $V = IR$, and they assume V and I refer to the **same component or section** of circuit. (For example, V^2/R gives the power in that resistor that has R and a voltage drop V across it.)

Limit Tests (Sanity Checks):

- If resistance $R \to 0$ (a short circuit), Ohm's Law predicts $V = I \cdot 0 = 0$. Indeed, an ideal zero-ohm path drops no voltage (short circuits have essentially 0 V across them, no matter the current). Conversely, even a tiny voltage applied across a near-zero resistor would produce a huge current $I = V/R$ – in reality this means a fuse blows or a circuit breaker trips if you short a voltage source, but mathematically $I \to \infty$ as $R \to 0$.
- If resistance $R \to \infty$ (an open circuit), Ohm's Law gives $I = V/R = 0$. No current flows if the circuit is broken or the resistance is extremely high – which checks out (open circuit means current is zero). The voltage can be anything, but with infinite resistance no current will flow.
- For the power formulas, check extreme cases: If $I = 0$, then $P = V \cdot 0 = 0$; no current means no power transfer (no work being done). If $V = 0$ across a component, $P = 0 \cdot I = 0$; no voltage difference means it's not delivering or absorbing energy, even if current were somehow flowing (which for a resistor implies it's a short doing no work). These make sense physically.
- Another check: if you double the current I through the same resistor R, the power $P = I^2R$ quadruples (since power grows with the square of current). This is a reminder that a small increase in current can significantly increase heating in a resistor, a practical sanity check when designing or analyzing circuits so you do not exceed power ratings.

Use vs. Sibling Equations:

- Use **Ohm's Law** $V = IR$ whenever you have a simple resistive relationship. It is the go-to formula for any DC circuit analysis involving resistors. Use it instead of unnecessary formulas: for example, do **not** confuse it with Kirchhoff's laws (which are about sums around loops or at nodes); Kirchhoff's Voltage Law (KVL) might tell you the sum of voltage drops equals zero around a loop, but *each drop* on a resistor still follows $V = IR$. Similarly, for capacitors or inductors, do not use $V = IR$ – those elements follow different relationships (coming in later subtopics).
- Use $P = VI$ for power calculations in any DC or resistive context. If the problem gives you a current and a voltage for a component, you can directly get the power in watts. Use the variant $P = I^2R$ if you know current through a resistor and its resistance, or $P = V^2/R$ if you know the voltage across a resistor and its resistance. These are all the same relationship, just algebraically rearranged for convenience. **Do not** use these DC power formulas for AC circuits with reactive components unless it's purely resistive or you're told to use RMS values, otherwise

you'd need the power factor (again, beyond this subtopic).

Common Exam Traps:

- **Unit Mix-ups:** Ensure you convert units. A classic mistake is using milliamps or kilohms without converting: e.g., a current of 5 mA and a resistance of 2 kΩ – if you just multiply 5 × 2, you'll get 10 (which is wrong by a factor of 1000×1000). Convert first: 5 mA = 0.005 A, 2 kΩ = 2000 Ω, then $V = IR = 0.005 \times 2000 = 10$ V. Likewise, for power, make sure V and I are in volts and amps.
- **Using values from different components:** If a circuit has multiple resistors, be careful to use the voltage drop *across the specific resistor* and the current *through that resistor* when using $P = VI$ or $P = I^2R$. Using the total supply voltage with a single resistor's resistance (when that resistor doesn't see the full supply voltage) is a common mistake. For example, if two resistors are in series splitting 12 V, each will have a portion of 12 V across it. Using the full 12 V with one resistor's R in $P = V^2/R$ would overestimate the power on that one resistor. Instead, find the resistor's own V (using voltage division or Ohm's law per element) before computing power for it.
- **Algebra mistakes:** Solving $V = IR$ for the desired quantity is usually straightforward, but under pressure it's possible to invert it by mistake. Remember the triangle mnemonic if it helps: draw a triangle with V on the top and I·R at the bottom corners – covering the one you want gives you the formula (cover V, you get IR; cover I, you get V/R; cover R, you get V/I). This can prevent accidental use of $R = I/V$ or $I = R/V$ which are incorrect.
- **Sign conventions:** In most exam problems, you'll deal with magnitudes of V and I. But if sign is mentioned (like "current direction" or "voltage drop vs rise"), use passive sign convention consistently. That means: if current enters the positive-labelled terminal of an element, $P = +VI$ gives the power *absorbed* by the element. If you get a negative power with that convention, it means the element is actually supplying power. A common trap is a question asking "how much power is delivered by the source?" – you might calculate $P = VI$ for the source and get a positive number, but if current enters the positive terminal of the source, a positive P actually means the source is absorbing power (which is unusual – sources normally deliver). Instead, if current enters the negative terminal of the source, then $P = VI$ will come out negative (meaning the source delivers power). In short: pay attention to phrasing about absorbing vs delivering power and use sign carefully. Usually, problems keep it simple and just ask for the magnitude of power dissipated in a resistor (which will be VI positive).

Exam Handbook Search Cues (Not affiliated with or endorsed by NCEES): *Ohm's law; V = I R; I = V/R; resistive power; P = V I; power dissipation*

Explanation & Analysis: To apply Ohm's Law and the power formulas effectively, start by identifying which element or portion of the circuit you are dealing with. **Ohm's Law (V = I R)** is essentially a one-element equation – it applies to a given resistor (or equivalent resistance of a set of resistors). For example, if a problem says "A 12 V battery is connected across a 3 Ω resistor. Compute the current," you recognize this as a direct Ohm's law application: $I = V/R = 12\text{ V}/3\ \Omega = 4$ A. Once you have that, a follow-up might be "How much power is dissipated in the resistor?" Using $P = VI$, you get $P = 12\text{ V} \times 4\text{ A} = 48$ W. Alternatively, you could use $P = I^2R = (4\text{ A})^2 \times 3\ \Omega = 48$ W or $P = V^2/R = (12\text{ V})^2/3\ \Omega = 48$ W. All roads lead to 48 W, reinforcing that these forms are consistent.

Term-by-term, $V = IR$ can be viewed as defining what resistance means: $R = V/I$, the ratio of voltage to current. A higher R for the same I means a higher required V (more "pressure" needed to push the current). Conversely, at fixed V, a bigger R yields a smaller I (less current flows if the circuit is more resistive). The power formula $P = I^2R$ shows that power grows quickly with current – if you double I, the heat dissipated by a resistor quadruples. This is why even a small increase in current can overheat a resistor if it's not rated for that power. The form $P = V^2/R$ tells us that for a given voltage, a smaller resistance draws more power (because it allows more current to flow). These insights can guide you in elimination on multiple-choice questions: if you increase resistance and everything else is the same, current drops and so should power; if you increase voltage, current increases (through a given resistor) and power goes up.

In summary, **use Ohm's Law as the first step** in many circuit problems (find V, I, or R as needed), and **use the power formulas as the second step** if asked about energy or power. They are straightforward, but their correct application relies on keeping track of which values go with which element, and on maintaining unit consistency. With practice, these become almost second nature – just be sure to double-check your algebra and units on exam day for these "easy" questions so you don't give away points due to a simple mistake.

K05.T01.S03 – Magnetic Flux

Principle Introduction: In magnetism, **magnetic flux** (Φ) is a measure of the total magnetic field passing through a given area. It's analogous to electric flux (for electric fields) or even to the idea of "flow" in a fluid sense – except it's not a material flowing, but field lines in a magnetic field. Magnetic flux is important in electromagnetic induction: when magnetic flux through a loop changes, it induces a voltage. For the FE Mechanical Exam, you might see magnetic flux mentioned in the context of inductors or transformers (for instance, understanding that an inductor's stored energy relates to flux, or that a changing flux induces an EMF by Faraday's Law). While you won't be solving complex magnetic field integrals, you should know what flux means, its units, and how it ties into basic formulas like Faraday's law or energy in inductors.

Definition Passport: Magnetic Flux (Φ)

- **Plain-language definition:** Magnetic flux is the amount of magnetic "field lines" passing through a surface. Formally, it's the surface integral of the magnetic flux density B over an area: $\Phi = \int \mathbf{B} \cdot d\mathbf{A}$. In simpler terms, if you have a loop or surface in a magnetic field, the magnetic flux Φ tells you how much of the magnetic field penetrates that loop. Imagine a loop of wire face-on to a uniform magnetic field: the more field (and the bigger the loop), the larger the flux through it.

- **Where it matters (exam impact):** Magnetic flux comes into play in problems involving **Faraday's Law of induction** and **inductors**. Faraday's law says that when the magnetic flux through a circuit changes, it generates an induced emf (voltage) given by $E =$

$-d\Phi/dt$; the minus sign reflects Lenz's law (the induced voltage opposes the change). In practical terms, if the exam asks about how a coil or transformer works, you might need to recognize that increasing or decreasing current changes flux which then induces a voltage. Also, the inductance L of a coil is defined by the flux linkage: $LI = N\Phi$ (for N turns) – though you may not need that formula explicitly, it explains that inductors store energy by building up flux.

- **Pitfall or confusion point:** Do not confuse **magnetic flux (Φ)** with **magnetic flux density (B)**. Flux Φ is a total amount (measured in webers), whereas B (measured in teslas) is like a concentration (field strength). For example, a strong magnetic field (B high in teslas) over a small area could produce the same flux as a weaker field over a larger area. The relationship (for a uniform field perpendicular to area A) is $\Phi = B \times A$. Also, watch the units: the SI unit of flux is the **weber (Wb)**. 1 weber is equal to 1 tesla·m² (since B in T times A in m² yields Φ in T·m²) – not to be mistaken with the tesla itself (tesla is per square meter, weber is the total). Another potential confusion: the symbol Φ is used for flux; it's a capital Greek phi. Don't mix it up with φ (phi) used sometimes for angles or the lowercase ϕ.

- **Micro-check:** *True or False:* The SI unit of magnetic flux is the tesla (T). → **False.** (Teslas measure flux density B, whereas magnetic flux Φ is measured in webers. One weber equals one tesla·square-meter.)

Exam Handbook Search Cues (Not affiliated with or endorsed by NCEES): *magnetic flux; weber; Faraday's law; inductance; flux linkage*

Footnotes:

- Magnetic flux is often visualized with **magnetic field lines**: by convention, the number of field lines crossing a loop is proportional to the flux. While field lines are just a visualization tool (they're denser where B is stronger), the concept can help – e.g. if you rotate a loop so that fewer lines go through it (because of angle), the flux decreases as $\Phi = BA\cos\theta$. If the loop is edge-on to the field (θ = 90°, $\cos 90° = 0$), essentially zero lines go through and flux is zero. This is why orientation matters: flux is maximum when the surface is perpendicular to the field and zero when parallel.

- One weber (Wb) is also equal to one volt-second (V·s). This comes from Faraday's law: a change of 1 Wb per second through a loop induces 1 V of EMF. So if you see units like V·s in a problem, recognize it as a weber.

Variations and Related Forms:

- **Faraday's Law:** $\mathcal{E} = -N\frac{d\Phi}{dt}$. This tells us that if the magnetic flux through a coil of N turns changes with time, the coil will have an induced voltage $\mathcal{E}$. The negative sign signifies Lenz's law (the induced voltage's polarity opposes the change in flux). In exam terms, you might not need to compute this explicitly, but qualitatively: *increasing* flux (like pushing a magnet into a coil) induces a voltage that drives a current opposing the increase; *decreasing* flux induces a voltage opposing the decrease. The key is understanding that a changing flux means induction.

- **Flux and Inductance:** Inductors create a magnetic flux when current flows through them. For a coil with N turns, the total flux linkage is $N\Phi = LI$. This can be rearranged conceptually as $\Phi = \frac{L}{N}I$ (though usually we consider $N\Phi$ together). The takeaway: flux in an inductor is proportional to current, and the constant of proportionality is the inductance (per turn). Higher inductance means more flux for the same current. This is why inductors resist changes in current – if you try to change the current rapidly, the flux changes rapidly and the inductor produces a voltage (by Faraday's law) to oppose that change.

- **Magnetic Flux Density B:** Sometimes a problem might give you B (in teslas) and an area, and ask for flux. Use $\Phi = BA\cos\theta$. For example, if $B = 0.5$ T uniform and perpendicular (θ=0) to a loop of 0.2 m² area, $\Phi = 0.5 \times 0.2 = 0.1$ Wb. If the orientation is 30° from perpendicular, $\Phi = 0.5 \times 0.2 \times \cos 30° \approx 0.0866$ Wb. So be aware of the angle if mentioned.

Explanation & Analysis: Magnetic flux can be a more abstract concept because you can't "see" it directly, but it helps to use physical intuition. Consider a loop of wire in a magnetic field. The **flux** Φ is essentially answering: *How much magnetic field penetrates this loop?* If the loop is bigger or the field is stronger, the flux is larger. If the loop is turned sideways to the field, the flux is smaller. Now, why do we care about flux? Because of **induction** – a changing flux is what gives us electricity from magnetism. In a generator, for instance, coils rotate in a magnetic field, causing the magnetic flux through the coil to vary cyclically; this induces an AC voltage. For the FE exam, you won't design a generator, but you could be asked conceptually what happens if, say, the current through an inductor is increased or decreased rapidly – the answer lies in changing flux and induced voltage.

In terms of problem-solving: if you are given any two of the three variables B, area A, and flux Φ, you can find the third with $\Phi = BA\cos\theta$ (assuming a uniform field and known orientation). Always express the area in m² and B in teslas to get flux in webers. If multiple turns are involved (like a coil of N loops), the total flux linkage is $N\Phi$, which might factor into induced voltage ($\mathcal{E} = -N\frac{d\Phi}{dt}$). A typical straightforward question might be: *"A magnetic field of 0.8 T is perpendicular to a 0.1 m² loop. What is the magnetic flux through the loop?"* You'd answer $\Phi = 0.8 \times 0.1 = 0.08$ Wb. Or a conceptual question: *"If the magnetic flux through a coil is increasing, what can you say about the induced voltage?"* Answer: It will induce a voltage (by Faraday's law) whose polarity acts to oppose the increase (Lenz's law).

Keep in mind that magnetic flux by itself might not be directly asked for often, but it underlies understanding inductors and transformers. Recognizing the term **weber** as a unit of magnetic flux, and Φ as a concept, will ensure you don't get thrown off by a reference to "flux" in a question scenario. It's one of those fundamentals that might appear as a keyword or in a conceptual option, so having a firm definition in your mind is important.

K05.T01.S04 – Characteristics of Resistors, Capacitors, and Inductors

Principle Introduction: Resistors, capacitors, and inductors are the three fundamental passive components in circuits. Each has distinct behavior: a **resistor (R)** converts electrical energy into heat and obeys Ohm's law at all times; a **capacitor (C)** stores energy in an electric field and resists variations in voltage; an **inductor (L)** stores energy in a magnetic field and resists changes in current. For the FE Mechanical Exam, you should grasp how each component behaves in simple circuits (especially DC conditions and energy storage). Questions may ask about equivalent capacitance or inductance in simple series/parallel setups, the energy stored in a capacitor or inductor given its voltage or current, or the qualitative behavior of these components when a circuit steady-state or transient is considered. Below is a comparative "passport" of these

passive components, highlighting their voltage-current relationships and energy formulas:

Table: Key Properties of Resistor, Capacitor, and Inductor

Component	Voltage–Current Relationship	Energy Stored (at given state)	Key Characteristic Behavior (DC context)
Resistor (R)	$v = i\,R$ (Ohm's Law)	*No energy stored* – converts $P = i^2R$ to heat continuously	**Dissipates energy:** Opposes current flow proportionally at all times. In DC steady-state, behaves the same (constant R).
Capacitor (C)	$i = C\,\frac{dv}{dt}$ (current leads voltage derivative)	$W_C = \frac{1}{2}C\,v^2$ (stored in electric field)	**Stores energy in electric field:** Opposes change in voltage. At steady DC, acts as an open circuit (no steady current through after charged). Cannot change voltage instantly (would require infinite i).
Inductor (L)	$v = L\,\frac{di}{dt}$ (voltage leads current derivative)	$W_L = \frac{1}{2}L\,i^2$ (stored in magnetic field)	**Stores energy in magnetic field:** Opposes change in current. At steady DC, acts as a short circuit (once current is constant). Cannot change current instantly (would require infinite v).

(In the table, v represents the voltage across the component and i the current through it. "Steady DC" means after a long time with DC applied; the capacitor is fully charged so current is zero, the inductor has settled to a constant current limited only by circuit resistance.)

Units: Capacitance C is measured in **farads (F)**, where 1 F = 1 coulomb/volt. Inductance L is measured in **henrys (H)**, where 1 H = 1 volt·second per ampere (V·s/A). These units are sizable: 1 farad is a very large capacitance (most practical capacitors are microfarads or nanofarads), and 1 henry is a large inductance (many inductors are in millihenrys). Resistances are in ohms as usual. In the energy formulas, notice that a capacitor's energy depends on voltage (v^2) while an inductor's depends on current (i^2), reflecting how each stores energy in a different field. The table above is created for clarity and does not duplicate any specific handbook table – it's an original summary for study purposes.

Typical Exam Moves:

- **Energy Calculation:** A common question is to compute the energy stored in a capacitor or inductor. For example: *"A 10 μF capacitor has 5 V across it; how much energy is stored?"* Use $W_C = 1/2\,CV^2$. Here $C = 10 \times 10^{-6}$ F, $V = 5$ V, so $W_C = 0.5 \times 10 \times 10^{-6} \times 25 = 1.25 \times 10^{-4}$ J (0.125 millijoules). Or *"A 0.2 H inductor carries 3 A; find its stored energy."* Use $W_L = 1/2\,LI^2 = 0.5 \times 0.2 \times 9 = 0.9$ J. These formulas are straightforward plug-ins – just watch the units (farads, henrys, etc.) and apply the ½ correctly.

- **Identifying Steady-State Behavior:** The exam might test if you know how capacitors and inductors behave after a long time in DC circuits. For instance: *"After a long time, what is the current through a capacitor connected to a battery via a resistor?"* The answer: zero, because the capacitor charges up and then no DC current flows through a capacitor once it's fully charged (it's open-circuited for DC). Or *"What is the voltage across an inductor long after a DC current is established?"* Answer: zero volts, because a steady current through an ideal inductor induces no changing flux, so no induced voltage – the inductor behaves like just a wire (short circuit) in steady DC. These concepts often come into play for RL or RC transient questions (e.g., just at switch closure vs long after).

- **Series/Parallel Combinations:** You might be asked to find an equivalent capacitance or inductance. Remember: capacitors add in parallel (like resistors in series) and capacitors combine in series like resistors in parallel. Inductors do the opposite: inductances add in series (like resistors in series) and combine in parallel like resistors in parallel (assuming no mutual coupling). For example, two capacitors of 5 μF in series yield $C_{eq} = (1/5 + 1/5)^{-1} = 2.5$ μF. Two 2 H inductors in parallel yield $L_{eq} = (1/2 + 1/2)^{-1} = 1$ H. This might appear as a step in a larger circuit problem.

- **Qualitative Change:** Sometimes the exam asks conceptually: *"If capacitance increases, what happens to the energy stored for the same voltage?"* Since $W_C = \frac{1}{2}CV^2$, if C increases, W_C increases linearly (more capacitance can store more energy at the same voltage). Similarly, more inductance L at the same current means more energy stored ($W_L = \frac{1}{2}LI^2$). Or, *"What happens immediately after a switch is opened in an inductor circuit?"* The current through an inductor cannot change instantaneously, so it will keep flowing (perhaps through a different path like a flyback diode or arc – but ideally one must be provided or the voltage will spike). Recognizing these physical realities can guide you to the correct answer in transient scenarios.

Common Pitfalls:

- **Mixing up formulas or units for W_C vs W_L:** It's easy under stress to confuse $1/2\,CV^2$ with $1/2\,LI^2$. A good way to remember: capacitance C goes with **V** (voltage) in the energy formula, and inductance L goes with **I** (current). Think "CV" and "LI" – C and V are a pair in the energy context, L and I are a pair. Also recall that increasing a capacitor's voltage or an inductor's current makes energy shoot up as the square of those quantities. If you accidentally use $1/2\,CI^2$ it would give meaningless units (since $C \times I^2$ in terms of units is F·A² which is not joules), so dimensional analysis can catch these errors.
- **Forgetting the ½ factor:** Both energy formulas have a one-half. This is because the voltage (or current) doesn't instantly rise to its final value when charging a capacitor (or current in an inductor) – the average during the charging process is half the final value, hence the ½ in the energy. If you forget the ½, you might overestimate stored energy by a factor of two. Always include that 0.5!

- **Using the wrong voltage or current in the formula:** Ensure you use the **voltage across the capacitor** in $W_C = \frac{1}{2}CV^2$. If the

capacitor is part of a larger circuit, the voltage across it might not be the source voltage; it could be divided or something – use the correct V for that capacitor. Similarly for inductor, use the current through that inductor. If multiple inductors or capacitors are present, isolate the one in question.

- **Misidentifying open/short behavior:** A frequent conceptual mistake is thinking a capacitor in steady state is a short or an inductor is open – it's the opposite. **Capacitor = open at DC steady state** (no DC current flows; it's like a broken wire after it's charged). **Inductor = short at DC steady state** (constant DC just sees it as a wire). At the **moment of switching (initial transient)**, the opposite is true: an uncharged capacitor initially acts like a short (allowing a surge of current until it charges), and an inductor initially acts like an open to sudden changes (you can't instantaneously establish current, so initial current change is resisted, meaning effectively no current flows if it started at zero). Keep these straight by remembering: capacitors resist change in voltage (so they hold whatever voltage they had initially, acting initially as a voltage source at the first instant of a switch, equivalently a short if initially uncharged at 0 V), whereas inductors resist change in current (holding initial current, acting initially as a current source, equivalently an open if initial current was 0 because it will not allow immediate current flow). These are deeper transient concepts, but even a basic problem might implicitly use them (for instance, to figure out an initial current spike or no-spike scenario).

Exam Handbook Search Cues (Not affiliated with or endorsed by NCEES): *resistor; capacitor; inductor; farad; henry; energy storage; ½CV²; ½LI²; series capacitor; parallel inductor*

Special Notes – Calculator Usage: For the energy formulas or any formula with squares, be mindful on your calculator to square the value before multiplying by C or L, and include the 0.5 factor. For example, to compute $W_C = 0.5CV^2$, you might enter it as $0.5 * C * (V)^2$ on a scientific calculator. Some exam-approved calculators have a square function or you can just multiply V by itself. Similarly, for W_L. It's straightforward but easy to mistype in a rush, so consider calculating in steps: first find V^2 or I^2, then multiply by C or L, then half it. This reduces the chance of forgetting the square or the half.

Explanation & Analysis: Each passive component plays a distinct role in circuit behavior, and understanding these roles helps you predict what a circuit will do:

- **Resistor:** It's conceptually the simplest – it follows $v = iR$ at every instant. It turns electrical energy into heat according to $P = i^2R$. There is no time-dependent memory; if you remove the voltage, the current stops immediately and no energy is stored. The resistor is our model for things like lamp filaments, heaters, or any device that just consumes energy steadily. In analysis, resistors are easy because they don't have dynamics – but they are crucial for setting steady currents and dividing voltages. Remember that all the energy that goes into a resistor is lost as heat (or light, etc.), not stored. So if an exam problem asks "where did the energy go?" in a resistive circuit, it's dissipated.

- **Capacitor:** A capacitor's defining equation $i = C\frac{dv}{dt}$ shows that the current through it is proportional to how fast the voltage across it is changing. This means if you want to change a capacitor's voltage quickly, you need a large current. Conversely, if no current can flow, the voltage stays constant ($dv/dt = 0$). That's why a capacitor opposes sudden changes in voltage. Intuitively, a capacitor is two plates storing equal and opposite charges; to change the voltage, you must move charge on or off the plates (that's what the current does). The energy $W_C = \frac{1}{2}CV^2$ is stored in the electric field between those plates. If a problem asks something like "what is the voltage on a capacitor after…", often conservation of charge or energy comes into play because the capacitor holds onto charge. In DC steady state, once the capacitor is charged up, it behaves like an open circuit: no DC current flows into a fully charged capacitor (because it's just two separated plates with an insulator, after all). This is important for analyzing circuits long after a switch – you can replace the capacitor with an open circuit for DC analysis.

- **Inductor:** An inductor's defining equation $v = L\frac{di}{dt}$ similarly indicates that the voltage across an inductor is proportional to how fast the current through it is changing. To change the current quickly, you need a large voltage. If no voltage is applied, the current stays constant ($di/dt = 0$). Thus, an inductor resists any abrupt change in current. Physically, an inductor is typically a coil of wire, and current through it creates a magnetic field. The energy $W_L = \frac{1}{2}LI^2$ is stored in that magnetic field. If the current tries to drop, the collapsing magnetic field induces a voltage to keep the current going (this is why inductors can cause sparks when a circuit is opened – the inductor produces whatever voltage is necessary to maintain current, up to breaking insulation!). For exam purposes, remember that in steady DC an ideal inductor is like a short circuit carrying the DC current with no voltage drop. When analyzing a long-term DC situation, you can replace the inductor with just a wire (short) because it will settle to whatever current it has with no voltage required across it. But at the instant of a change, an inductor can behave as a current source (maintaining initial current).

In summary, knowing these characteristics allows you to tackle problems systematically: identify which components store energy and which dissipate it, apply the correct formulas for energy if needed, and simplify circuits in steady-state extremes (initial or final) by replacing capacitors or inductors with opens or shorts appropriately. The FE Mechanical Exam isn't heavy on advanced circuit theory, but it expects you to be comfortable with the basics: using $\frac{1}{2}CV^2$ and $\frac{1}{2}LI^2$, combining capacitors or inductors, and understanding the qualitative behavior of these passive components. With these "passports" in hand, you can approach any relevant problem with confidence, knowing which formula or principle to apply and how each component will act.

Topic 02 - DC Circuit Analysis

Topic Introduction: DC Circuit Analysis covers the fundamental laws and methods used to analyze direct-current electrical circuits. On the **FE Mechanical Exam**, you'll face problems asking for currents through components, voltage drops across elements, equivalent resistance of networks, or power dissipated/supplied by certain elements. These typically involve applying **Kirchhoff's Laws** (for conserving charge and energy), simplifying resistor networks (series/parallel combinations), using **Thévenin/Norton equivalents** to reduce complex networks, and performing **DC power** calculations. Mastering this topic means you can systematically break down any circuit into simpler parts, ensuring you find the right values without error. Expect questions like *"Given a circuit with several resistors and sources, what is the current through a specific resistor?"* or *"What is the power dissipated by a component or delivered by a battery?"* – all solvable by the core principles in this chapter.

K05.T02.S01 – Kirchhoff's Laws (KCL and KVL)

Principle Introduction: Kirchhoff's two laws are the backbone of circuit analysis, enforcing conservation of charge and energy in electrical networks:

- **Kirchhoff's Current Law (KCL)** – At any node (junction) in a circuit, **the total current entering equals the total current leaving**. No current is lost; it's essentially a statement of charge conservation.
- **Kirchhoff's Voltage Law (KVL)** – Around any closed loop in a circuit, **the sum of all voltage rises equals the sum of all voltage drops**. This reflects energy conservation: a full loop's net voltage change is zero (what you gain from sources you lose across drops).
- KCL applies to junctions (nodes) and is used to write **nodal equations**, ensuring current continuity. KVL applies to loops and is used to write **loop/mesh equations**, ensuring the energy gained from sources is fully expended in drops.
- These laws hold for **DC circuits** (as well as AC) under steady conditions, and you'll typically use them along with Ohm's law to solve for unknown currents or voltages. In exam problems, identifying which nodes or loops to apply KCL/KVL to is often the first step to set up equations.

Kirchhoff's Current Law (KCL) – *Conserves charge at a node by equating inflow and outflow of electric current.* In formula form, for any node:

$$\sum I_{\text{entering}} = \sum I_{\text{leaving}}.$$

Variables and units: - I – Electric current in a branch connected to the node (amperes, A). Each I entering or leaving is taken with a sign or side (entering vs leaving) as defined by your chosen convention.

Assumptions and scope: - The node is in steady state – no net charge accumulation. (Any capacitance is either absent or not accumulating charge in the DC steady state, so current flowing in immediately flows out.) - Currents are defined consistently: you must decide which directions count as "entering" vs "leaving" and stick with it (passive sign convention isn't directly about KCL, but consistency is key). KCL works for any lumped circuit node or a closed boundary encompassing a junction. - Valid for DC and AC circuits (frequency doesn't matter for KCL). Even with time-varying currents, at any instant the law holds (instantaneous currents sum to zero at a node).

Limit tests (sanity checks): If only one wire carries current into a node and only one carries current out, KCL simply implies those two currents are equal. If a node has, say, 5 A entering on one side and 3 A exiting on another, KCL demands an additional 2 A must exit through some other branch (5 A in = 3 + 2 A out) – if you **"lose" or "gain" current** in your calculations, you've violated KCL (check for a missing branch or sign error). No matter how many connections meet, you can't have more current leaving than entered (or vice versa) without something magical (or a capacitor charging, which is temporary and involves a changing node voltage).

Use vs. sibling equations: Use **KCL for node analysis** (summing currents at a junction) instead of writing separate device equations when you want a quick relation among currents. In contrast, use **KVL** when you need to relate voltages in a loop. They complement each other: KCL for currents at junctions, KVL for voltages in loops.

Common exam traps:

- **Sign convention mix-ups:** If you arbitrarily assign current directions and then write KCL as "sum = 0," be careful to treat currents leaving as positive and entering as negative (or vice versa). A common mistake is adding some currents as entering and others as leaving in the same sum incorrectly. A reliable approach is: *Sum of currents leaving a node = 0* (meaning currents entering would be negative in that equation). For example, suppose 2 A enters a node and 3 A leaves via another branch, and there is an unknown third branch current I_x. If we take currents *leaving* as positive, KCL gives $-2\text{ A} + 3\text{ A} + I_x = 0 \Rightarrow I_x = -1\text{ A}$. The negative sign simply means our assumed direction for $I_x$was opposite the actual current. If you **forget** the minus sign on the entering current and write $+2 + 3 + I_x = 0$, you'd get $I_x = -5\text{A}$, which doesn't match the physical picture and signals a sign-convention mistake.

- **Ignoring a connection:** Make sure to include *all* branches connected to the node. It's easy to forget a branch, especially one connected to ground or a reference node. Every wire counts!

- **Misidentifying nodes:** Sometimes what looks like separate nodes may actually be connected (e.g. through an ideal wire) and should be treated as one node for KCL. Failing to recognize that leads to writing invalid KCL equations (and often too many of them).

Kirchhoff's Voltage Law (KVL) – *Conserves energy around a loop by ensuring the net sum of voltage changes is zero.* In formula form for any closed loop:

$$\sum \text{voltage rises} = \sum \text{voltage drops},$$

which is equivalent to $\sum_{\text{loop}} \Delta V = 0$ (taking rises as positive and drops as negative, or vice versa, in one consistent sum).

Variables and units: - Voltage rises/drops – Each term is a voltage change across a circuit element (volts, V). A "rise" could be, for example, going from the negative to positive terminal of a battery (gain +V), and a "drop" might be going through a resistor in the direction of current (voltage falls IR across it).

Assumptions and scope: - The loop is taken in a static electromagnetic condition (no changing magnetic flux through the loop). In DC circuits this is true by default – nothing is changing with time, so Faraday's law isn't generating any extra voltages. (KVL can momentarily fail if a loop contains an inductor with a changing current or a moving magnetic field – but those are time-varying situations outside steady DC analysis.) - All components are lumped and well-behaved (no weird distributed effects). Essentially, KVL assumes the sum of device voltages around the loop fully accounts for the source voltage(s). - Polarity for each element's voltage is defined consistently with the loop traversal direction. Decide a direction to "walk" the loop (clockwise or counterclockwise) and stick to it, labeling each element with a polarity for that pass (for example, if you go through a resistor in the same direction as current, you experience a drop $-IR$; opposite the current, a rise $+IR$).

Limit tests (sanity checks): If your loop has only a 10 V battery and a single resistor dropping voltage, KVL demands that the resistor drop is also 10 V (so 10 V source = 10 V drop). If you found, say, 8 V drop, there's 2 V unaccounted for – a clear red flag. As a check, sum of rises minus drops should equal zero. If you traverse a loop and algebraically sum to a nonzero value (like +5 V), it indicates an error: either a polarity sign mistake or a missing element. Physically, a nonzero sum would mean you'd gain or lose energy after one lap around the circuit, which doesn't happen (imagine a rollercoaster that mysteriously ends 5 m higher than it started – energy would not be conserved).

Use vs. sibling equations: Use **KVL for loop/mesh analysis** when you need relationships between voltages. For example, to relate the voltage of a source to the drops across several series resistors, KVL is your go-to. Compare this with **Ohm's Law** (which relates V, I, R for a single element) – KVL strings together multiple elements. Use KVL instead of writing separate device equations when you want one consolidated equation for a loop's behavior. If multiple loops exist, you might write a KVL equation for each. Don't confuse KVL with KCL: use KVL around closed loops (voltage sums), not at nodes (that's KCL's job).

Common exam traps:

- **Incorrect polarity assignment:** This is the #1 source of sign errors. A tip: mark a "+" and "–" on each element *before* writing the equation, according to the direction you plan to traverse. If you go through a source from – to +, call that $+V$; through a resistor in current direction, call it $-IR$, etc. Many students lose track and effectively double-count a rise or drop.

- **Forgetting a term:** Ensure every element in the loop is included. If a loop passes through 5 elements, you need 5 terms. Sometimes a ground or reference connection can be sneaky – if your loop goes through a ground node difference, include the zero difference (or avoid looping through ground separately, stick to element-by-element).

- **Mixing up loops:** In circuits with multiple loops, a common mistake is to mix terms from two different loops into one equation. Each independent loop equation should stand on its own. If you're using the mesh current method, remember to account for shared elements properly (a shared resistor's drop might be $I_{mesh1} - I_{mesh2}$ times R if two mesh currents flow through it in opposite directions).

- **Using KVL where it doesn't directly apply:** If a problem involves induced EMFs or time-varying fields (rare in FE Mechanical DC context), KVL in its simple form might not hold. On the exam, this is unlikely – stick to standard DC circuits and you'll be fine.

Exam Handbook Search Cues (Not affiliated with or endorsed by NCEES): "Kirchhoff's laws", "KCL (current law)", "KVL (voltage law)", "nodes and loops", "voltage, current law"

Footnotes:

- KCL is sometimes stated as "$\sum I = 0$ at a node" (with currents leaving considered positive, then currents entering are negative in that summation). This is mathematically identical to $\sum I_{\text{in}} = \sum I_{\text{out}}$. Choose whichever phrasing makes it easiest for you to be consistent.

- When applying KCL, a **node** means any junction where two or more components connect. If a wire runs through without a branch, it's still the same node. Merging what you think are separate points into one node can simplify analysis (e.g. all points connected by an ideal conductor have the same node potential and can be treated as a single node for KCL).

- KVL's "closed loop" can be any path that starts and ends at the same node and goes through a set of elements once. You do *not* necessarily need to follow the actual current flow direction – you can loop in any direction (clockwise or counterclockwise). The key is consistency: if you decide to go clockwise, keep that direction and count voltage rises/drops accordingly. If you reverse direction, every rise becomes a drop and vice versa (yielding the same equation multiplied by -1).

- Both laws assume **lumped circuits** (no weird distributed parameters or RF effects). In plain terms, that means we assume wires have no resistance or induction (so voltage only changes across components, not along ideal wires), and charge doesn't pile up at nodes (if it did, the node voltage would change until currents balance).

- If you find these laws seem "obvious", that's good – they are intuitive. But systematically applying them in complex circuits takes practice. In exam conditions, write down KCL/KVL equations clearly; it's easy to make a mental slip under pressure. When in doubt, slow down and explicitly sum currents or voltages in writing to avoid trapping yourself in an algebra error.

Explanation & Analysis (Step-by-Step): Kirchhoff's laws are usually applied early in a circuit problem, before plugging in numbers, to set up relationships:

- **Using KCL:** Identify a node where currents converge. For example, say a node connects three resistors. Label the currents I_1, I_2, I_3 in each branch (choose a direction for each, typically pointing *out* of the node for consistency). Now write KCL: $I_1 + I_2 + I_3 = 0$. This means whatever current leaves through $I_1 + I_2$ must be coming in through I_3, or vice versa. If you have current values, you plug them in; if not, you might express each current via Ohm's law. For instance, if those branches go to other nodes of known voltages, you'd write each current as $(V_{\text{node}} - V_{\text{other}})/R$. Setting the sum to zero

yields an equation you can solve for the unknown node voltage or current.

- **Always double-check directions:** if your solution gives a negative current, it just means the actual current goes opposite to the arrow you assumed – the KCL equation itself is still valid.
- **Using KVL:** Pick a loop (often around a set of elements forming a closed path, usually including a source). For example, imagine a simple loop with a 12 V battery and two resistors in series. Start at the battery's negative terminal and go around clockwise. If you go from battery (–) to (+), that's a +12 V rise. Then you go through resistor R_1 (say current I flows through it from + to – end), that's a drop $-IR_1$. Next resistor R_2 similarly gives $-IR_2$. Returning to where you started completes the loop. KVL says: $+12\text{ V} + (-IR_1) + (-IR_2) = 0$. Simplify: $12 = I(R_1 + R_2)$. This is essentially how you derive series circuits behavior (and indeed matches Ohm's law applied to the combined resistance). On the exam, you'd likely have numbers to plug in: if $R_1 = 3\ \Omega, R_2 = 5\ \Omega$, then $12 = I(8)$ so $I = 1.5$ A. With KVL, once you have current, you could find each resistor's drop: $V_1 = 1.5 * 3 = 4.5\text{ V}, V_2 = 1.5 * 5 = 7.5\text{ V}$. Check: do they sum to 12? Yes (4.5 + 7.5 = 12). It's a good habit to verify the loop sum comes back to zero with your solved values – it reassures you that you didn't mis-assign polarities or miss a component.
- **Plan of attack:** In a larger circuit, you might have multiple nodes and loops. You can often choose between KCL or KVL (or do both). A systematic approach is *nodal analysis* (writing KCL at essential nodes) or *mesh analysis* (writing KVL for independent loops). Either method ultimately uses both laws in some form. For FE-level problems, usually the circuit is small enough that you can use whichever seems more straightforward:

  If many elements meet at a junction but there's essentially one big loop (like a fan-out and fan-in), nodal/KCL might be easier.

  If it's more like a ladder or multiple loops sharing components, mesh/KVL might be cleaner.
- **Double-Checking Solutions:** After solving, always plug your found currents back into a KCL at a busy node – do they sum to zero (within rounding)? If yes, likely correct. Similarly, sum voltages in each loop you considered – do they net to zero? If not, recheck polarities or calculations. These laws are great error check tools; if your answer violates KCL or KVL even slightly, something's off (except minor rounding).
- **Physical intuition:** KCL basically says *"charge is not piling up or vanishing at a node."* If 5 C of charge per second (5 A) flows into a junction and only 3 C/s flows out through one wire, the remaining 2 C/s **must** flow out somewhere else (another wire), or momentarily charge would build and the node voltage would shift until balance is achieved. For DC steady state, assume it's balanced. KVL says *"you can't get free energy by going around a circuit."* If you start at some point and go around returning to it, you might gain energy in sources but you lose exactly that energy in resistors or other drops – like climbing a mountain and descending, your net elevation change is zero when you're back where you started. If you find a loop where adds and drops don't cancel, you've essentially claimed energy appeared or disappeared – check your math, because nature doesn't give freebies on the FE exam!

K05.T02.S02 – Series and Parallel Combinations (Resistances & Sources); Network Simplification

Principle Introduction: Real circuits often have many resistors and sources. **Network simplification** techniques allow you to reduce a complex network step-by-step by combining elements in **series or parallel**. This makes it easier to find overall resistances, currents, or voltages. Key ideas include:

- **Resistors in series** combine by addition. When resistors are connected end-to-end in a single path (no branching), they all carry the same current. You can replace them with one equivalent resistor whose resistance is the sum. This simplifies analyzing the circuit since multiple drops become one drop across the equivalent.
- **Resistors in parallel** combine via reciprocals. When resistors share both their nodes (they're each connected across the same two points, providing multiple current paths), they all see the same voltage. You can replace them with a single equivalent resistor given by the reciprocal of the sum of conductances (the result will always be lower than the smallest individual resistance).
- **Combining sources:** Ideal sources can sometimes be combined too (with caution). Voltage sources in series (like batteries stacked) add algebraically (taking polarity into account). Current sources in parallel add algebraically (taking direction into account). These source combination tricks can simplify circuits with multiple sources into a single effective source, but only when they are indeed in pure series or pure parallel configurations.
- **Voltage and current division:** Once you simplify a network, you can expand back out to find individual element values. In a series chain, the voltage divides in proportion to resistance (voltage divider rule). In parallel branches, current divides in inverse proportion to resistance (current divider rule). These rules directly come from series/parallel behavior and are extremely handy for quick calculations on exam day.
- **Strategy on the exam:** Often you'll identify parts of the circuit that are obviously in series or in parallel and collapse them. Simplify step by step: for instance, combine a pair of parallel resistors into one, then notice that equivalent is now in series with another resistor, and so on. Redrawing the circuit after each combination helps. The end goal might be finding one total resistance or simplifying to apply Ohm's law easily. Remember to keep track of what each equivalent resistor represents so you can back-substitute if needed to find specific branch values.



Resistors in series share a single path with the same current (diagram left: two resistors R_1, R_2 connected end-to-end between Node 1 and Node 2). Resistors in parallel share both connection nodes and the same voltage (diagram right: R_1, R_2 each connect between Node 1 and Node 2 in parallel). Series resistances simply add up, whereas parallel resistances combine via reciprocals to yield an equivalent resistance lower than each individual resistor.

Equation Passport – Equivalent Resistance (Series & Parallel)

– Combines multiple resistors into a single resistance that has the same effect on the circuit. For n resistors $R_1, R_2, \ldots, R_n$ in series or in parallel:

- **Series:** $R_{\text{eq(series)}} = R_1 + R_2 + \cdots + R_n$.
- **Parallel:** $R_{\text{eq(parallel)}} = \frac{1}{\frac{1}{R_1}+\frac{1}{R_2}+\cdots+\frac{1}{R_n}}$.

(For the special case of two resistors in parallel: $R_{\text{eq}} = \frac{R_1 R_2}{R_1+R_2}$, which is often easier to compute.)

Variables and units: - $R_1, R_2, \ldots, R_n$ – Resistances of individual resistors (ohms, Ω). - R_{eq} – Equivalent resistance of the combined network of those resistors (ohms, Ω). This single resistor draws the same total current and has the same total voltage as the original combination when placed in the circuit.

Assumptions and scope:

These formulas assume a **direct connection** in pure series or pure parallel:

- Series: The resistors are chained one after another. This means the same current passes sequentially through each resistor, with no branching point in between. (In practice, that means the resistors share a common node exclusively with each other, no other element connecting at that node except the two resistors).

- Parallel: All resistors' leads connect to the same two nodes. This means each resistor is independently connected across the same voltage. There must be no difference in how each resistor connects between those nodes (no extra elements in between one of them and the node, etc.). Each resistor's ends are directly tied to the two common nodes.

- The resistors are **static (linear) and independent**. Their values don't change with voltage or current (ohmic behavior). If there were dependent resistances or nonlinear elements, these simple combinations might not hold straightforwardly. - These are valid in DC and AC for resistances (for AC impedances, series/parallel combine similarly but with complex numbers – for DC we stick to real resistances).

- The network has no other connection or element in the mix of the series/parallel group. (For instance, if a third node comes off between resistors, those two aren't purely series anymore – that third node means a possible branch, changing everything.)

Limit tests (sanity checks):

- For series: If you have just one resistor ($n = 1$), the formula gives $R_{\text{eq}} = R_1$ (makes sense – one resistor is its own equivalent). If one resistor in series is zero (a short circuit wire, $R = 0$), it adds no resistance: e.g. $R_1 = 0, R_2 = 5\Omega$ gives $R_{\text{eq}} = 5\Omega$. If one resistor is extremely large (open circuit, $R \to \infty$), the series sum $\to \infty$ – an open in series means no current can flow, infinite effective resistance.

- For parallel: If one resistor is extremely large ($R \to \infty$, essentially an open circuit branch), its contribution $1/R$ is zero, so it can be removed without affecting the equivalent. Example: $R_1 = 100\Omega$ in parallel with $R_2 = \infty$ (open) gives $R_{\text{eq}} = 100\Omega$. If one resistor is zero ($R = 0$, a short across the nodes), $1/R$ is infinite – effectively the equivalent resistance becomes 0 (a direct short dominates any finite resistances in parallel). If all resistors are equal, say R each in parallel, then $1/R_{\text{eq}} = n(1/R)$ so $R_{\text{eq}} = R/n$. For example, two 100 Ω in parallel give 50 Ω (half), four in parallel give 25 Ω (a quarter), etc – a useful check for mental math.

- The equivalent resistance in parallel should **always** be less than the smallest individual resistor (unless one is zero which yields 0). If your parallel calculation yields something higher than one of the resistors, something went wrong (common error: forgetting to invert the sum, e.g. mistakenly summing resistances instead of conductances).

- In series, the equivalent is always greater than or equal to the largest individual resistor (with equality only if others are zero). If your series result comes out smaller than one of the components, you likely made an arithmetic error.

Use vs. sibling techniques: Use these equivalent resistance formulas **instead of repeatedly applying KVL/KCL** for each resistor when you only need the overall effect. For example, to find total current from a battery through several series resistors, it's faster to add them into one R_{eq} and do $I = V_{\text{battery}}/R_{\text{eq}}$. Similarly, use the parallel formula instead of solving current splits with systems of equations; it gives you the single equivalent. These formulas are siblings to the **voltage divider and current divider** rules: rather than finding an equivalent, you might directly compute how voltage or current splits (more on that in a moment). Choose the approach that fits the question – if it asks for the combined

resistance, use these formulas; if it asks for a particular branch current or voltage, sometimes a divider formula is quicker.

Common exam traps:

- **Forgetting to invert for parallel:** The most notorious mistake – adding resistances like $R_1 + R_2$ for a parallel case by accident. Always double-check: parallel combination involves that reciprocal formula. It can help to do it stepwise: first compute $G_{\text{eq}} = 1/R_1 + 1/R_2 + \cdots$ (that gives total conductance in siemens), then invert $R_{\text{eq}} = 1/G_{\text{eq}}$.

- **Incorrectly identifying series vs parallel:** Just because two resistors are drawn next to each other doesn't mean they're in series – if there's another connection in between, they're not in simple series. Likewise, resistors drawn seemingly parallel might have a slight difference in connection that breaks true parallel. Always trace the actual nodes: resistors share both nodes = parallel; resistors share one node and nothing else in between = series.

- **Combining when not allowed:** If there's a dependent source or something between resistors, don't lump them blindly. Also, never combine non-similar elements with these formulas (e.g., don't try to "add" a resistor and a capacitor's impedance as if both were resistances at DC – at steady DC, a capacitor is open circuit (∞ resistance) and inductor is short (0 resistance)). In pure DC analysis, treat capacitors as opens and inductors as shorts for long-term steady state before combining network resistances. - **Unit consistency:** Resistances might be given in kΩ or MΩ. Convert to a common unit (e.g. ohms) before combining, or be careful to keep track (e.g. 2 kΩ + 3 kΩ = 5 kΩ is fine; but $1/\left(2\ \text{k}\Omega^{-1} + 3\ \text{k}\Omega^{-1}\right)$ is best done by converting to ohms or using the calculator carefully with parentheses).

- **Combining sources incorrectly:** Only combine ideal sources when they are truly in series or parallel *with no other elements between*. For instance, two batteries in series directly one after the other can add voltages. But if a resistor or load sits between them, you can't just add them as one source – that resistor makes it a different topology. Similarly, current sources in parallel must connect directly together to the same nodes. If they do, you can replace them by one current source equal to the sum (if directions are same) or difference (if opposite directions) with the common node polarity of the stronger source. Don't attempt to combine a voltage source and a current source directly via these rules – that requires more advanced transformation (Thevenin/Norton method, coming up next).

- **Rounding in intermediate steps:** When using these combinations in multi-step simplifications, avoid rounding too early. For example, combining 47 Ω and 56 Ω in parallel: $R_{\text{eq}} = (47 * 56)/(47 + 56) \approx 25.3\Omega$. If you round to 25 Ω and then use that in further calc, you might introduce small errors. It's often fine, but just be mindful – in an FE exam context, they usually pick numbers that combine nicely or allow a certain tolerance.

Exam Handbook Search Cues (Not affiliated with or endorsed by NCEES): "resistors in series", "resistors in parallel", "equivalent resistance", "Ohm's law", "network simplification"

Footnotes: - The exam reference handbook provides these formulas (series sum and parallel reciprocal) under basic electrical engineering formulas. It might list the parallel form as $R_P = 1/(1/R_1 + 1/R_2 + \cdots)$ explicitly and even the two-resistor shortcut. Knowing them by heart speeds you up considerably.

- **Series vs Parallel quick ID:** A quick visual cue – series components are **in line** with each other (like a single path with no junctions between), whereas parallel components are **stacked between the same nodes** (their leads share nodes, creating multiple paths). If you redraw the circuit and see a clean single chain, that's series; if you can see a "ladder rung" connecting the same two points, that's parallel.

- Be cautious with **units of large combinations**: if you combine a lot of resistors, sometimes the equivalent can come out to a value that is nicely simplified (like 2.5 Ω or 1.333 Ω). The exam may leave a fraction form or a decimal – both are fine. Just make sure you provide an answer in standard form (e.g. 4/3 Ω or 1.33 Ω, not an unsimplified fraction).

- Realize that you can apply these combination rules beyond just resistors: for DC analysis, **conductances** (reciprocals of resistances) in parallel add, which is analogous to capacitors in parallel or inductors in series (in electric circuits, those analogies exist: e.g., capacitors combine like resistors in parallel for their capacitance values).

- When combining **voltage sources in series**, add their voltages (with sign). E.g., two 1.5 V batteries in series oriented + to – will give 3 V total. But if one is flipped opposite, their voltages subtract (net 0 V if equal and opposite – essentially they cancel out, leaving just internal resistances if any). For **current sources in parallel**, if two 5 A sources feed the same node pair in the same direction, together they supply 10 A (to whatever load connects). If opposite, one will subtract from the other (a 5 A and 3 A in opposite directions effectively yield a 2 A net source in direction of the larger one).

- Avoid unrealistic combinations: The exam won't likely give you nonsensical source combos (like two different ideal voltages directly in parallel – that would theoretically cause infinite current). If you see such a scenario, it's either a trick expecting you to note it's not allowed or there's an implicit internal resistance. In normal cases, stick to combining only identical voltage sources in parallel (which just behaves like one source of that voltage but capable of more current) or identical current sources in series (which is unusual and essentially just one current source if they force the same current).

Variations, Related Forms, Typical Values:

- **Voltage Divider Rule:** In a series circuit, the voltage drop on resistor R_x out of the series chain R_{total} is $V_x = V_{\text{source}} \frac{R_x}{R_{\text{total}}}$. This handy formula comes straight from Ohm's law and the fact that current is common: $I = V_{\text{source}}/R_{\text{total}}$, and $V_x = IR_x$. So $V_x = V_{\text{source}}(R_x/R_{\text{total}})$. Use this when you need the voltage on one resistor but don't want to solve for current first. Typical application: Two resistors in series forming a **voltage divider** – the node between them will be at a fraction of the source voltage. e.g., 8 V across 2 resistors 2 Ω and 6 Ω: the drop on 2 Ω is $8 * (2/8) = 2$ V, on 6 Ω is $8 * (6/8) = 6$ V.

- **Current Divider Rule:** In a parallel network, the current through one branch I_x (through R_x) from the total current I_{total} splitting into two branches (say R_x and R_y) is $I_x = I_{\text{total}} \frac{R_y}{R_x + R_y}$. Notice the **opposite**: it uses the *other* branch's resistance in the numerator, because a larger resistance draws proportionally less current. If more than two branches, a generalized form is $I_x = I_{\text{total}} \frac{1/R_x}{\sum(1/R)}$ (i.e. allocate currents by conductance fraction: branch conductance over total conductance). For example, if 10 A comes into a node that

splits between a 5 Ω and 15 Ω resistor to ground, the 5 Ω (lower resistance, higher conductance) will draw $10 * \left(15/(5+15)\right) =$ 7.5 A, and the 15 Ω gets $10 * \left(5/(5+15)\right) = 2.5$ A. Indeed 7.5+2.5 =10 A and matches the ratio logic (the 5 Ω takes 3 times the current of the 15 Ω since it's 1/3 the resistance).

- **Delta-Wye (Δ–Y) Transformations:** In more complex three-node networks (like a triangle of resistors), you can't combine any two by simple series/parallel. A more advanced simplification is the delta to wye transform (or vice versa) – converting a triangle of three resistors into an equivalent star (Y) of three resistors connecting to a central node. The formulas are given in some references, but if such appears on the FE, it would likely provide the formula or be set up so you don't actually need to do it. Use this only if you recognize a true delta (Δ) of resistors with no easy combos. It's a bit beyond typical FE Mechanical scope, but just know it exists as a technique.

- **Typical Values:** For the FE exam, expect resistor values that play nicely. You might see common resistor numbers (1, 10, 100; 2, 4, 8; 1.5, 3, 6, etc.). They often choose values that make the math neat (e.g., two in parallel giving an integer). For instance, 2 Ω || 3 Ω = 6/5 = 1.2 Ω, or 5 Ω || 5 Ω = 2.5 Ω. If your math is giving something very messy, double-check if you made a mistake or if perhaps the answer is meant in fractional form. Also recall standard resistor tolerance series (1.0, 2.2, 4.7, etc.) in case a question uses them; you're not required to memorize that, but it can sometimes hint at nice fractions.

Special Notes (Calculator Tips): Computing parallel combinations is a common task – make sure you know how to do it efficiently on your calculator: - Using a scientific calculator, you can sum reciprocals by either using the $1/x$ key or doing it manually. For example, to compute $1/(R1^{-1} + R2^{-1})$, you might do: R1 [1/x] + R2 [1/x] = to get $1/R_1 + 1/R_2$, then hit [1/x] again to invert that sum. This minimizes parentheses fuss. - If you have a chain of combinations, use the memory registers to store intermediate results. For instance, combine two resistors, store the result, then combine with the next.

- **Avoid rounding intermediate results** as mentioned earlier. Many FE calculators keep at least 8-10 digits internally, which is fine. Just be cautious if you write down a rounded value and re-enter it. - For series sums, it's straightforward: just add them. But don't forget to convert units if needed. For example, 2.2 kΩ + 5.6 kΩ = 7.8 kΩ (which is 7800 Ω if later you need it in ohms for another calculation).

- **Unit conversions:** 1 kΩ = 1000 Ω, 1 MΩ = 10^6 Ω. Sometimes it's easiest to do parallel in those unit forms by factoring (e.g. R_{eq} of 200 kΩ || 50 kΩ: note 50 kΩ is 1/4th of 200 kΩ, so the result is 40 kΩ; if that logic isn't obvious, convert to ohms: 200k and 50k → $1/(1/200000 + 1/50000)$ ohm, you could compute but noticing the ratio saved time).

- **Check extremes with your calc:** If you accidentally do something like "$1/R_1 + 1/R_2$" and forget to invert for final, your result will be off. One sanity check is dimension: parallel combination must be in ohms, which for equal resistors ends up smaller. If you computed 1/Ω and left it that way, your number might be like 0.02 (dimensionless) when the resistors were, say, 50 Ω and 50 Ω. Recognize that as not a valid resistance but rather the conductance in S (siemens). Then invert it.

- Lastly, it can help to label intermediate nodes or draw simplified schematics as you combine sections. This reduces confusion about what's left in your circuit after each step – a practice that can prevent errors especially when the circuit has multiple combination stages.

Explanation & Analysis (Step-by-Step): Simplifying circuits by combining resistors and sources is often like solving a puzzle. Here's how you might approach it:

1. **Identify simple series or parallel groupings:** Look at the circuit diagram and find any obvious pairs or groups. For example, if two resistors are directly end-to-end with nothing else connected at their junction, they're in series – combine them. If two resistors share both connection points, they're in parallel – combine them. It's like scanning for parts of the circuit that form a simple pattern.
2. **Redraw the circuit after each combination:** After combining one group (say, merging two parallel resistors into R_{eq}), sketch the new simpler circuit. This new circuit will have one less element and maybe a different topology that could reveal *new* series or parallel combos. Iteratively, you might collapse a complex network into one equivalent resistor between two terminals.
3. **Combine sources when applicable:** If you see, for instance, two ideal voltage sources in series in the same loop (and no other element between them), you can add or subtract their voltages into a single source. Make sure their polarities are aligned when adding. For current sources in parallel feeding the same node, add their currents. Be mindful: *don't combine sources that aren't purely in series or parallel.* If unsure, leave them and apply other methods (like nodal analysis). The FE exam usually structures things so you won't encounter a totally paradoxical source setup unless the question is theoretical.
4. **Use the equivalent to find overall quantities:** Once you reduce the circuit to its simplest form (maybe a single voltage source and a single R_{eq}), you can easily find total current or total voltage. For example, a 10 V source feeding a single R_{eq} of 5 Ω means $I_{total} = 10/5 = 2$ A. That might be one of the questions – "What is the supply current?" or something similar.
5. **Expand back out if needed:** If the question asks for a value in one of the original elements, you'll take the overall result and work backward. For instance, suppose the question is "What is the current through resistor R_2?" If you combined a bunch of resistors to find total current, now distribute that current according to how you collapsed things. If R_2 was in series in a chain, the current through it is the same as the total current you found. If R_2 was part of a parallel branch you collapsed, you'd use current divider to find how that total current splits back into the branch with R_2.
6. **Check consistency:** After doing all this, it's wise to double-check a few things: e.g., if you found the current through each branch, do they sum back up to the source current (KCL)? If you found voltages across series pieces, do they add to the source voltage (KVL)? These are redundant checks but are quick ways to catch mistakes, exactly as described in subtopic S01.
7. **Example (walk-through):** Consider a simple network: a 12 V battery is connected to two resistors $R_A = 100\ \Omega$ and $R_B = 300\ \Omega$ in series, then that goes into a node that splits into two parallel resistors $R_C = 200\ \Omega$ and $R_D = 200\ \Omega$ before returning to the battery's negative. This might look complicated at first glance. Break it down:

8. R_A and R_B are in series (same path). Combine them: $R_{AB} = 100 + 300 = 400\ \Omega$.
9. Now the circuit is a 12 V source feeding $R_{AB} = 400\ \Omega$ in series, then reaching a node, where it splits into R_C and R_D in parallel to ground. Combine $R_C| \quad |R_D$: since they're equal (both 200 Ω), $R_{CD} = 200/2 = 100\ \Omega$. (Using formula $1/(1/200 + 1/200) = 100$.)
10. Now we have a simplified circuit: a 12 V source, series $R_{AB} = 400\ \Omega$, then series $R_{CD} = 100\ \Omega$ (the parallel combination became a single resistor). Actually, careful: R_{CD} is connected from that node to ground, and R_{AB} is from source to that node, so yes effectively they are in series from source to ground as well (the node between them doesn't go elsewhere now that we combined the parallel part).

    So total $R_{\text{eq}} = R_{AB} + R_{CD} = 400 + 100 = 500\ \Omega$.

    Total current from the 12 V source: $I_{\text{total}} = 12\ \text{V}/500\ \Omega = 0.024$ A (24 mA).
11. The question might ask "What is the current through R_D?" Initially, R_D was one branch of the parallel. Now we know the node feeding R_C and R_D had 24 mA going in, which split equally (because the two resistors were equal). So $I_{R_D} = 12$ mA. Alternatively, using current divider formula: $I_{R_D} = I_{\text{node}} * \left(R_C/(R_C + R_D)\right) = 0.024 * \left(200/(200 + 200)\right) = 0.012$ A. Either way 12 mA.
12. Check: 12 mA in R_C and 12 mA in R_D sum back to 24 mA into the node, good. Voltage at that node (drop across R_{AB}) = $I * R_{AB} = 0.024 * 400 = 9.6$ V. That leaves 2.4 V across R_{CD} (since total 12 V). Indeed each of the 200 Ω in parallel has 2.4 V across it (makes sense: 12 mA * 200 Ω = 2.4 V). 9.6 + 2.4 = 12, checks out with KVL. We're consistent.
13. This example shows the power of combining: doing it piecewise was far easier than writing 3 KCL/KVL equations and solving simultaneously.

Combining sources example: If you have two 6 V batteries in series facing the same way, just add to get 12 V. If one was reversed, you'd subtract: net 0 V if equal (they fight each other, effectively no net voltage but you might have a loop current if there's a path, which is a different scenario). For current sources, say two ideal current sources of 2 A each feeding into a node from the same side – if both push current into the node, node gets 4 A to distribute. If one pushes 5 A in and another pushes 3 A in the opposite direction (i.e. one is actually drawing from the node), the net is 2 A into the node (5 in vs 3 out). Usually, you won't be asked to combine sources explicitly unless it's straightforward; more often, Thevenin/Norton conversion (next topic) is the method to handle sources systematically.

Bottom line: Series/parallel reductions simplify the *structure* of circuits. Practice spotting these patterns; often a seemingly daunting circuit is just two or three combo steps away from a one-resistor equivalent. That skill will save you time and reduce errors in exam conditions. And if direct combination isn't obvious, you can always fall back on writing KCL/KVL equations – but that tends to be slower.

K05.T02.S03 – Thévenin's and Norton's Equivalent Circuits

Principle Introduction: Thévenin's theorem and **Norton's theorem** are powerful network simplification methods, letting you replace an entire linear circuit by a simple equivalent seen from two terminals. This is extremely useful when you want to focus on a particular part of the circuit (like a load) without re-solving the whole network every time the load changes. Key points:

- **Thévenin Equivalent:** Any combination of voltage sources, current sources, and resistors that obey linear relationships can be reduced to a single **voltage source** V_{oc} in series with a **resistance** R_{eq} (often called R_{Th}). V_{oc} is the open-circuit terminal voltage (with no load connected), and R_{eq} is the equivalent resistance seen when looking into the circuit after all independent sources have been deactivated.
- **Norton Equivalent:** The same circuit can equally be represented as a single **current source** I_{sc} in parallel with a **resistance** R_{eq} (called R_{No} but it's the same value as R_{Th}). I_{sc} is the short-circuit current that would flow if the terminals were shorted together.
- **Relation between them:** $I_{\text{sc}} = V_{\text{oc}}/R_{\text{eq}}$. In other words, the Norton current is just the Thévenin voltage divided by the equivalent resistance (Ohm's law relating the two forms).
- These equivalents greatly simplify analyzing how different loads will behave. For example, you can convert a complicated network to a Thévenin equivalent and then easily calculate the current through a resistor load using simple series division. Or use the Norton form to quickly get how a load splits current.
- **Maximum Power Transfer:** A special result from these equivalents is that a load receives maximum power from the network when the load resistance R_L equals the Thévenin/Norton resistance R_{eq}. At that matching condition, power transfer is optimized (with half the source voltage dropping on the load). This is sometimes directly tested.
- On the exam, you might be explicitly asked to "find the Thévenin equivalent seen by terminals A-B" or something similar. Or, indirectly, they might give a circuit with a variable load and ask for the load current or power – a hint that using Thévenin/Norton could be the fastest route.

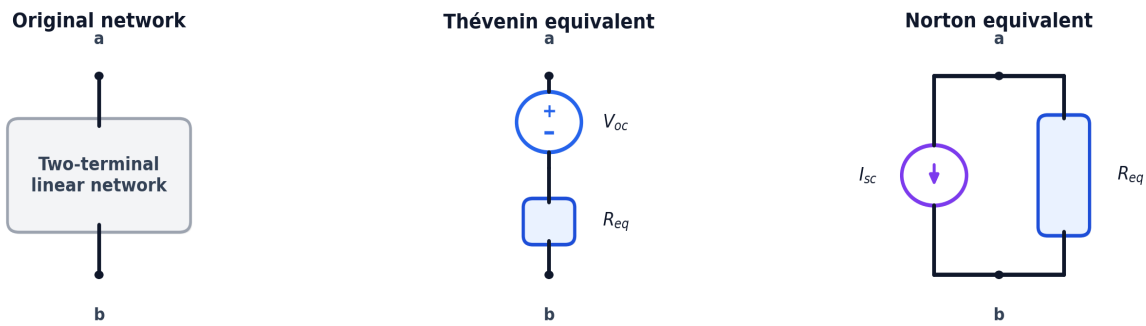

Any two-terminal linear network (left, represented as a grey box of sources & resistors between terminals a and b) can be simplified. Thévenin equivalent (diagram center-left) is a single voltage source V_{oc} in series with a resistor R_{eq}. Norton equivalent (diagram center-right) is a single current source I_{sc} in parallel with the same R_{eq}. These two forms are interchangeable: $I_{sc} = V_{oc}/R_{eq}$. A given load R_L connected across terminals a–b will see the same voltage and draw the same current no matter whether you connect it to the original network, the Thévenin, or the Norton – provided V_{oc}, I_{sc}, R_{eq} are correctly determined.

Definition Passport – Thévenin & Norton Equivalents:

- **Thévenin's Theorem:** *"Any linear two-terminal circuit can be replaced by an equivalent circuit consisting of a single voltage source in series with a single resistance, which will produce the same terminal behavior."* In plain language, from the perspective of the load hooked to the two terminals, it doesn't matter if there was a complicated mess behind those terminals or just a simple battery + resistor – as long as the open-circuit voltage and internal resistance match, the external load cannot tell the difference.
- **Norton's Theorem:** *"Any linear two-terminal circuit can be replaced by an equivalent circuit consisting of a single current source in parallel with a single resistance, yielding the same behavior at the terminals."* This is basically the current-source version of Thévenin.
- These equivalents matter on the exam especially when you have a circuit with a lot of sources and resistors feeding a particular component (like a sensor or motor). Instead of analyzing the full circuit for each scenario, you collapse it once into a Thévenin or Norton form, then answer anything about different R_L easily.
- **Micro-check:** True or false? *The Thévenin resistance R_{eq} is found by "turning off" all independent sources in the original circuit and measuring/inputting a test current at the terminals.* – **True.** (Turning off means set voltage sources to 0 V (short circuit) and current sources to 0 A (open circuit), then find the net resistance seen. If dependent sources exist, you inject a test source.)

Equation Passport – Key Quantities for Thévenin/Norton:

Name and purpose: **Open-Circuit Voltage V_{oc} & Short-Circuit Current I_{sc}** – determine the Thévenin/Norton equivalent sources. V_{oc} is the voltage across the terminals when no load is connected (open circuit). I_{sc} is the current through the terminals when they are directly shorted together. Both are characteristics of the network as seen from the outside.

- **Open-Circuit Voltage:** $V_{oc} = V_{ab}$ with terminals a–b open (no load). This is the Thévenin voltage source value.
- **Short-Circuit Current:** I_{sc} = current flowing from a to b when terminals a–b are shorted (connected with a wire). This is the Norton current source value.
- **Equivalent Resistance:** $R_{eq} = \frac{V_{oc}}{I_{sc}}$. Also found by deactivating sources: e.g., R_{eq} = input resistance at terminals a–b with sources turned off (voltage sources→shorts, current sources→opens).

Variables and units: - V_{oc} – Open-circuit voltage (volts, V) across the terminals (a to b) of the original network with no load. Sometimes called V_{Th} (Thévenin voltage). - I_{sc} – Short-circuit current (amperes, A) that flows from a to b when the terminals are shorted together. Sometimes called I_N (Norton current). - R_{eq} – Equivalent resistance (ohms, Ω) seen by the load. Also called Thévenin resistance R_{Th} or Norton resistance R_N. In a passive linear network, this is just a single value in ohms.

Assumptions and scope:

- The original circuit is **linear** and bilateral (contains resistors, independent/dependent sources – but no nonlinear elements like diodes, and no frequency-dependent stuff for DC analysis). Linearity means superposition holds, which underpins these theorems.

- Independent sources are treated properly when "turned off": an ideal voltage source becomes a short (0 V difference, like a wire) because it will hold zero volts if "turned off"; an ideal current source becomes an open (0 A through, like a break) if turned off. Dependent sources, if present, are not turned off (they depend on circuit variables); in that case, determining R_{eq} might require a test source. - V_{oc} assumes no load, so no current leaves the terminals. I_{sc} assumes a perfect short, so the terminal voltage is 0 in that condition. These extreme conditions are theoretical but used to characterize the network.

- The load you eventually connect is also assumed not to alter the internal source/resistance values (i.e., we're not depleting a source or something – sources are ideal with infinite supply). - These

equivalents are used for **analysis convenience**; physically, you haven't changed the circuit as far as the load is concerned. But internally, note that the Thévenin or Norton is conceptually what the external load "sees".

Limit tests (sanity checks):

- If the original circuit has no independent sources (only resistors), then $V_{oc} = 0$. The Thévenin equivalent would be just a 0 V source (which is basically a short) in series with R_{eq}, meaning effectively just R_{eq} alone. The Norton equivalent would be 0 A current source (which is an open) in parallel with R_{eq} – again effectively just R_{eq}. This is logical: a purely resistive network with no sources just looks like one equivalent resistor.

- If you short the terminals and find I_{sc}, and open the terminals to find V_{oc}, plugging them into $R_{eq} = V_{oc}/I_{sc}$ should yield the same R_{eq} you get by turning off sources. If they mismatch, something went wrong in calculation.

- The values V_{oc} and I_{sc} are not independent – they are related through R_{eq}. If one is zero, the other must be zero *or* R_{eq} is infinite (which could happen: e.g., if $I_{sc} = 0$ but $V_{oc} \neq 0$, that suggests an infinite internal resistance – practically, that means the network behaves like a current source of 0 current in Norton form, which is weird. Usually, if $I_{sc} = 0$ then V_{oc} should also be 0 for a normal passive network. If $V_{oc} = 0$ but $I_{sc} \neq 0$, then $R_{eq} = 0$ – the network is like a short or pure current source with no voltage potential, which typically implies something like an ideal wire or ideal current source dominating).

- Check extreme load cases: If you connect $R_L = 0$ (short the output) to the Thévenin, you'd get $I_{sc} = V_{oc}/R_{eq}$. If you connect $R_L = \infty$ (open circuit) to the Norton, you'd get V_{oc} as the open-circuit terminal voltage. These should be consistent with the original network's behavior.

Use vs. sibling methods: Use the **Thévenin/Norton approach** when you have a fixed circuit and multiple potential loads or questions focusing on the external behavior. It saves time compared to solving the full circuit for each scenario. If you only have one scenario and few elements, normal KCL/KVL is fine – but the theorems shine when isolating a part of the circuit. Think of it this way: rather than solving a complex circuit over and over for different external conditions, solve it *once* into a Thevenin (voltage source + R) and then you can treat that like a simple source for any load. The "sibling" of this approach is **source transformation**: converting a given voltage source + series resistor into a current source + parallel resistor (and vice versa). In fact, Thevenin <-> Norton conversion *is* just that kind of source transformation at the whole-circuit level. Use source transformation for intermediate steps if needed as well – sometimes you can spot a part of the circuit that is just a V source in series with R and convert it to I with parallel R to then see an easier combination, etc.

Common exam traps:

- **Calculating R_{eq} incorrectly:** The most common error is forgetting to turn off sources properly. For example, say you have a 10 V source and some resistors. To find R_{eq}, you must replace that 10 V source with a short (wire) – if you instead incorrectly remove it or leave it as 10 V, your equivalent resistance will be off. Likewise, for a current source, you must remove its effect by opening it. Another mistake is ignoring dependent sources: if a dependent source is present, you cannot turn it off; you might have to attach a test 1 A source and compute voltage or something to get R_{eq}.

- **Sign conventions for V_{oc} and I_{sc}:** Be careful with the sign/polarity. Decide which terminal is a and which is b, and measure $V_{oc} = V_a - V_b$ clearly. If you swap, you'll just get a sign inversion which can be okay as long as consistent. Similarly, I_{sc} direction – define positive I_{sc} as flowing from a to b through the short. If your computed current goes the opposite, you'll get a negative value, which is fine (it just means the current actually flows from b to a). The magnitude is what matters for R and such, but the sign is needed if the question asks e.g. "direction of current".

- **Forgetting R_{eq} includes looking back into entire network:** Sometimes students mistakenly think R_{eq} is just the resistor that might be physically in series with a source in the original circuit. Not necessarily – if the network has several resistors in more complex arrangement, you have to combine them all appropriately (with sources off) to get the single R_{eq}. It's essentially the input resistance at the terminals.

- **Applying Thévenin to nonlinear or time-varying cases:** The theorem strictly holds for linear circuits at a given operating point. If an exam question has something like a diode or a transistor (unlikely in FE Mechanical), you'd linearize or use other methods. But typical FE circuits are linear.

- **Max power transfer confusion:** The max power transfer condition $R_L = R_{eq}$ is sometimes confused with an efficiency condition. Remember, when $R_L = R_{eq}$, you get maximum *power* delivered to the load (which is only 50% efficient because the source also dissipates the same in its internal resistance). If they ask for the value of load that maximizes power, you use R_{eq}. If they ask for the maximum power itself, you can compute $P_{\max} = \frac{V_{oc}^2}{4R_{eq}}$. A trap is to plug the wrong values – e.g., using total source voltage vs. V_{oc} or mixing up internal/external R. Make sure you identify which part is considered the "source" side versus the "load" side.

Exam Handbook Search Cues (Not affiliated with or endorsed by NCEES): "Thévenin equivalent", "Norton equivalent", "source transformation", "open-circuit voltage", "short-circuit current", "maximum power transfer"

Footnotes:

- Pronunciation tip (for no credit, just so you know): "Thévenin" is pronounced like "TEV-uh-nan" (French name), and "Norton" like the antivirus software or the motorcycle brand. Not that it matters for the exam, but maybe it helps remembering – Norton is straightforward current form, Thévenin is the voltage form.

- Thévenin and Norton equivalents are mutually convertible: $V_{oc} = I_{sc}R_{eq}$. If you find one form, you inherently have the other. Sometimes it's easier to find one of the two first: e.g., a circuit with mostly current sources and parallel elements might scream Norton, whereas one with voltage sources and series elements is easier as Thévenin. Go with whichever is simpler to derive, then convert if needed.

- When **turning off sources**: For a voltage source, replacing it with a short means connecting its two terminals with a wire (essentially 0 Ω between them). For a current source, replacing with an open means removing it and leaving no connection (infinite resistance gap). Conceptually, this is because an ideal voltage source can

provide any current to maintain 0 V if it's set to zero, effectively acting like a wire, and an ideal current source at zero current is like no current through an infinite resistance, hence an open circuit.

- Some students ask: *"Why does maximum power transfer occur at $R_L = R_{eq}$?"* – It's a symmetric situation: when load equals internal resistance, half the voltage drops internally, half on load, resulting in the optimal product $V_{load}I$. If load is too small (relative to internal), it draws more current but the voltage across it becomes small (most drops internally) so power goes down. If load is too large, it gets a big fraction of voltage but tiny current, again low power. The sweet spot is equal. This is basically a calculus optimization of $P_L = V_{oc}^2 \frac{R_L}{(R_L+R_{eq})^2}$ peaking at $R_L = R_{eq}$. - Not every problem requires explicitly stating "this is the Thévenin resistance" etc. Sometimes you do the steps without naming them. But recognizing when a circuit is a candidate for this approach can save time. For instance, if the question gives a circuit and then asks about two different load scenarios, definitely consider Thévenin – solve the network once, then plug in load 1 and load 2.

- **Dependent sources note:** If a dependent source is present (like one that depends on a current or voltage elsewhere in the circuit), to find R_{eq} you cannot just turn it off (since it's controlled by something). In that case, either find V_{oc} and I_{sc} and divide, or use a test source method: attach a 1 A current source at the terminals, find the voltage it produces (with original sources off if independent ones exist), and that voltage will equal $R_{eq} * 1\text{A}$. This is more of an edge case, but good to know in case such a scenario appears.

- Thévenin/Norton also imply **superposition**: The calculation of V_{oc} can often be done by superposition if multiple sources – turn on one source at a time (keeping others off) and sum the contributions at the output. I_{sc} likewise. This can sometimes be easier than solving simultaneous equations.

- It's fine on the FE exam to just use conventional circuit analysis to find the load current or whatever directly without explicitly stating "by Thevenin's theorem...", but conceptually you might be doing the same thing. The advantage of explicitly finding the equivalent is clarity and reusability for multiple parts.

Explanation & Analysis (Step-by-Step): To **find a Thévenin or Norton equivalent** between two points (say terminals a and b) systematically, follow these steps:

1. **Find V_{oc}:** Remove any load between the terminals, leaving them open. Calculate the voltage across the terminals. This might involve solving a sub-circuit using KCL/KVL or voltage division, etc. For example, if the terminals are across a resistor, with no load that resistor might not carry current, simplifying the circuit. Determine which side is positive relative to the other for reference. This open-circuit voltage is your Thévenin voltage V_{Th}.
2. **Find R_{eq}:** Turn off all independent sources:
3. Set all independent voltage sources in the circuit to 0 V (replace each with a wire).
4. Set all independent current sources to 0 A (remove each, leaving an open). Now, with that modified circuit, find the equivalent resistance seen from the terminals. Often this means combining resistors that were previously connected to those sources now in simpler series/parallel ways. Sometimes you can literally imagine attaching an ohmmeter across a and b and computing what it would read. That resistance is R_{eq}. If there are dependent sources, a further trick: inject a hypothetical 1 A current source into the terminals and find the voltage drop it causes; that voltage drop in volts is numerically R_{eq} (since V=IR and I=1).

(Or alternative) Find I_{sc}: Instead of step 2's method, you can do this: short the terminals a–b directly with a wire. Calculate the current that flows through that short from a to b. This might involve solving a loop or nodal scenario. That current is I_{sc}. Once you have I_{sc} and already have V_{oc}, compute $R_{eq} = V_{oc}/I_{sc}$. This approach can be more intuitive in some circuits. For example, if the nodes a and b are output of a voltage divider, I_{sc} is like putting a wire across the divider output – you'd find the short current by seeing how much goes through that wire.

Build the equivalents: Now you can write the Thévenin form as a voltage source of V_{oc} in series with a resistor R_{eq}. Draw it out with the correct polarity for V_{oc} as found. Or write the Norton form as a current source I_{sc} in parallel with R_{eq} (with direction as found for I_{sc}). These are equivalent from the perspective of the terminals.

Use the one appropriate for the task: If a load R_L is to be attached, you can choose either form to compute what you need:

With the **Thévenin** (voltage source + series R): attach R_L in series with R_{eq}. Now it's a simple series circuit: you can find current $I_L = V_{oc}/(R_{eq} + R_L)$. Then the voltage across R_L is $I_L * R_L$ (or via divider: $V_{oc} * R_L/(R_{eq} + R_L)$). Power on R_L would be $I_L^2 R_L$ or V_L^2/R_L.

"With the Norton (current source + parallel R): attach R_L in parallel with R_{eq} . Now it's a simple current divider: the current through R_L is" $I_L = I_{sc}\frac{R_{eq}}{R_{eq}+R_L}$ (because current splits inversely to resistance). The voltage across R_L will be that current times R_L. You can also find the node voltage by the formula $V = I_{sc}(R_{eq} \| R_L)$ where ($R_{eq} \| R_L$) means the parallel combination of R_{eq} and R_L. Equivalently, $V = I_{sc}\frac{R_{eq}R_L}{R_{eq}+R_L}$.

Both methods yield the same answers, just pick what's comfortable. Thévenin form is usually more directly intuitive for most (voltage dividing across series resistor and load), but Norton can be algebraically cleaner if you're summing currents.

Verify extremes: As a quick check, apply two extremes to your equivalent and see if it matches the original circuit behavior:

1. No load (open circuit, $R_L \to \infty$): Thévenin says no current flows, so terminal voltage stays V_{oc}. Norton says no current flows into R_L because open, so all current goes through R_{eq} as internal, hence terminal voltage $= I_{sc} * R_{eq} = V_{oc}$. Good. Compare to original: if your original network was open, did you compute the same V_{oc}? Yes by definition.
2. Dead short (load = 0): Thévenin says current $I = V_{oc}/(R_{eq} + 0) = V_{oc}/R_{eq}$ flows, and terminal voltage is 0 (all drop is internal $I * R_{eq}$). Norton says the short takes all current I_{sc} leaving 0 V, maybe some splitting if R_{eq} was there but essentially yes, the short across output

means R_{eq} is also shorted out so current source goes entirely through the short, generating I_{sc} flow. Either way, check that predicted short current equals original I_{sc}.

3. If those boundary conditions check out, your equivalent is consistent.

Example (numerical): Let's do a concrete example. Suppose we have a voltage divider supplying a load: a 20 V ideal source feeding two resistors $R1 = 4\ \Omega$ and $R2 = 6\ \Omega$ in series, then output across $R2$ (between the node connecting R1-R2 and ground). We want the Thévenin equivalent seen by that output node and ground (i.e., with R1 and R2 as part of the source network and output at node between them).

1. First, find V_{oc}: That's the voltage at the node when no load is connected. It's just the divider output. $V_{oc} = 20 * \frac{R2}{R1+R2} = 20 * 6/(4+6) = 20 * 0.6 = 12$ V. So Thévenin voltage is 12 V (node positive w.rt ground).
2. Next, find the equivalent resistance R_{eq}. Turn off the 20 V source by replacing it with a short circuit. Now $R_1 = 4\ \Omega$is effectively directly from the node to ground, since one end of $R_1$was connected to the 20 V source, which is now shorted to ground. Resistor $R_2 = 6\ \Omega$is also from the node to ground (it was originally connected that way). Thus, with the source turned off, $R_1$and $R_2$are in parallel between the node and ground. The equivalent resistance is $R_{\text{eq}} = R_1 \parallel R_2 = \frac{R_1 R_2}{R_1+R_2} = \frac{4\times 6}{4+6} = \frac{24}{10} = 2.4\ \Omega$.
3. Alternatively, we could find I_{sc}: Short the output node to ground. That effectively bypasses R2 entirely (it is in parallel with a 0Ω path, so no current goes through R2). The 20 V source then sees just R1 from its positive to ground (since node is ground via short). So short-circuit current $I_{sc} = 20\ \text{V}/4\ \Omega = 5$ A. Now check $V_{oc}/I_{sc} = 12/5 = 2.4\ \Omega$, same R_{eq}.
4. The Thévenin equivalent: 12 V source in series with 2.4 Ω. Norton equivalent: 5 A source in parallel with 2.4 Ω (the 5 A direction from node to ground corresponding to original 20 V driving current downwards).
5. Now attach a load $R_L = 4\ \Omega$. Using the Thévenin equivalent, the load current is $I_L = \frac{V_{\text{th}}}{R_{\text{th}}+R_L} = \frac{12}{2.4+4} = \frac{12}{6.4} = 1.875$ A. The load voltage is $V_L = I_L R_L = 1.875 \times 4 = 7.5$ V. Using the Norton equivalent, a 5 Asource feeds the parallel combination of $R_{\text{th}} = 2.4\ \Omega$and $R_L = 4\ \Omega$. By current division, the current through the 4 Ωload is $I_L = 5\ \frac{2.4}{2.4+4} = 5 \times 0.375 = 1.875$ A, and the corresponding node (and load) voltage is again $V = I_L R_L = 1.875 \times 4 = 7.5$ V. We can also verify this directly from the original circuit. The node is connected to ground through $R_2 = 6\ \Omega$and the load $R_L = 4\ \Omega$in parallel, and to the 20 Vsource through $R_1 = 4\ \Omega$. The parallel combination of 6 Ωand 4 Ωis $R_{24} = 6 \parallel 4 = \frac{6\times 4}{6+4} = 2.4\ \Omega$, so the total series resistance seen by the source is $R_{\text{tot}} = R_1 + R_{24} = 4 + 2.4 = 6.4\ \Omega$. The source current is therefore $I = \frac{20}{6.4} = 3.125$ A, and the node voltage from a simple divider is $V = 20\ \frac{R_{24}}{R_1+R_{24}} = 20\ \frac{2.4}{6.4} = 7.5$ V, which matches the Thévenin and Norton results.

6. If the question asked maximum power in R_L: That happens when $R_L = R_{eq} = 2.4\Omega$. The max power would be $P_{max} = V_{oc}^2/(4R_{eq}) = 12^2/(4 * 2.4) = 144/(9.6) = 15$ W. You could confirm by plugging $R_L = 2.4\Omega$ into the current formula: $I = 12/(2.4 + 2.4) = 12/4.8 = 2.5A$. Power in $R_L = I^2 R_L = 6.25 * 2.4 = 15W$. If R_L were higher or lower, you'd get less than 15 W (e.g. $R_L = 4\Omega$ gave 7.5 V & 1.875 A → 14.06 W, slightly less).

Using source transformations directly: Sometimes you don't have to derive from scratch – you can convert parts of a circuit stepwise. For example, if you have a known Thevenin pair (like a 10 V source with 5Ω series), you can flip it to a Norton (2 A with 5Ω parallel). This might let you combine it easily with other parallel current sources or resistors. After simplifying, maybe convert back to a Thevenin, etc. This agility with source transformations is essentially using Thevenin/Norton on the fly.

Big picture: Thevenin and Norton give you *perspective*. By reducing a network, you gain insight: R_{eq} tells you how "stiff" the source is (low R_{eq} means it can drive loads with little voltage drop, like an ideal voltage source; high R_{eq} means it's very sensitive to load, like a weak source or high internal resistance). V_{oc} tells you the no-load max voltage, I_{sc} the max short current. These are like a Thevenin battery's open-circuit voltage and internal resistance characteristics. Engineers use this concept beyond exams to model things like the output of sensors, amplifiers, power supplies, etc., in a simple way.

In the FE exam context, trust that if they ask for Thevenin or Norton explicitly, it should boil down cleanly. Follow the steps, double-check with basic KCL/KVL if needed, and use the equivalent to quickly answer any follow-up parts (like what happens when R_L is such-and-such).

K05.T02.S04 – DC Power and Energy in Circuits

Topic Introduction: Electrical **power** in DC circuits quantifies the rate of energy conversion – how much energy per second is delivered by sources or dissipated/absorbed by components. In exam problems, you might be asked to compute the power dissipated in a resistor, the power output of a supply, or the energy usage of a device over time. The basic relationships between voltage, current, resistance, power, and energy are crucial:

- **Power** P (in watts) is given by the product of voltage and current: $P = V \times I$. This applies to any component at any instant. Depending on what values are known, you can use Ohm's law to get alternative forms (for resistors, $P = I^2 R = \frac{V^2}{R}$). These forms help compute power quickly from whichever quantities are given.
- **Sign convention:** By passive sign convention, if P comes out positive for a component, it's absorbing power (dissipating energy, e.g. resistor turning electric energy into heat). If P is negative, the component is delivering power (like a battery providing energy to the circuit).
- **Energy W** (in joules or in watt-seconds) is power integrated over time: \(W = P \times t for constant power, or $\int P(t)dt$ in general. In DC circuits, if conditions are steady, you can use $W = P \cdot \Delta t$ to find energy consumed or supplied over a period.
- The exam may test your ability to use these formulas in contexts like: *"Find the power dissipated by a 5 Ω resistor with 3 A through it,"* or *"A device draws 2 A from a 9 V battery. How long can a 9 V, 2000 mAh*

battery last?" (that second one involves converting amp-hours to coulombs and relating to energy).

- Also, conservation of energy in circuits means the sum of power delivered by sources equals sum of power absorbed by loads (in an ideal lossless circuit). This can be a check: if you calculate power for each element, the algebraic sum (taking supply as negative, loads positive) should be zero.

Equation Passport – DC Electrical Power: *Calculates the instantaneous power associated with an element given its voltage and current.* The fundamental relationship and its resistor-specific forms are:

$$P = V\,I = I^2\,R = \frac{V^2}{R},$$

for an element with voltage V across it and current I through it. (All forms are equivalent via $V = IR$. Use the form that matches your known values.)

Variables and units:

- P – Power, measured in **watts (W)**. 1 W = 1 joule per second. Positive P means power being absorbed by the component, negative means power being delivered by it (if you use passive sign convention: current enters the positive-labeled terminal of the element for $P = +VI$).

- V – Voltage across the element (volts, V). Specifically, V is the potential difference between two terminals. If using passive sign convention for power, V is defined positive at the terminal where the current enters.

- I – Current through the element (amperes, A), entering the positive voltage terminal if following passive sign convention.

- R – Resistance of the element (ohms, Ω). The forms I^2R and V^2/R apply when the element in question obeys Ohm's law $V = IR$ (true for resistors or any ohmic device).

Assumptions and scope:

- These formulas assume **steady DC conditions or instantaneous values** at a given moment. In a DC circuit, everything is constant in time (after initial transients), so P is constant for each element. - The resistor forms I^2R and V^2/R specifically assume a linear resistor relationship between V and I. If the element isn't a simple resistor (say a diode or a black box), you should stick to $P = VI$ directly (which is always true by definition of power). - The sign convention is crucial. The formula $P = VI$ implicitly assumes passive sign convention. If you've labeled the voltage drop from the positive node to negative node on the element and I enters at the positive node, then $P = VI$ is positive for absorption. If instead current enters the negative side (meaning the element is actually supplying power), plugging in the assigned polarities yields a negative P. Another way: You can compute $P = VI$ with magnitudes and then later assign a sign by thinking "is this element giving or taking power?" but it's safer to get it systematically with sign conventions. - Units must be consistent: V in volts, I in amperes → P in watts. If using kV and mA, for example, either convert to V and A or realize that kV*mA will give kW (since 1000 V * 0.001 A = 1 W, so it works out).

Limit tests (sanity checks): - If $V = 0$ across a component, it's either a short or no potential difference – then $P = 0 * I = 0$. This makes sense: a short wire with current but no voltage drop ideally dissipates no power (superconductor scenario). But be careful: in reality, a wire has tiny resistance and will heat if current flows, but ideal wires don't in circuit theory. - If $I = 0$ through a component (open circuit, no current flow), $P = V * 0 = 0$. Makes sense: no current, no energy transfer, even if there is a voltage present (like an open battery has voltage but delivers no power until connected). - If you increase current, power increases linearly (P ~ I for fixed V) or quadratically (P ~ I^2 for fixed R). If you increase voltage, similarly power goes up (P ~ V^2 for fixed R). - For a given resistor, if you double the voltage, you quadruple the power ($P = V^2/R$). Doubling current quadruples power ($P = I^2R$). This means power can escalate quickly with higher voltage or current – something to keep in mind in design and in exam calcs (e.g., a small change in voltage might drastically increase thermal dissipation needs). - The formula forms cross-check each other. If you compute P using VI and using I^2R and get different numbers, then likely the values of V, I, R you used aren't consistent (maybe you used a wrong R or wrong I for that R). They must agree if the numbers are correct.

Use vs. sibling equations: Use these DC power formulas **instead of AC formulas** (like $P = VI\cos\phi$ which involves power factor, or reactive power concepts) when dealing with steady DC or purely resistive circuits. There's no cosine or phase angle in DC – cos(0) = 1 essentially, so it simplifies. Also use these rather than mechanical power formulas (like $P = \tau\omega$ for rotating systems or $P = Fv$ for linear motion) unless you are converting between electrical and mechanical in a given problem (e.g., a motor's electrical input vs mechanical output). If you are dealing with energy storage elements (capacitors or inductors), note that instantaneous power can still be computed by VI (and is absorbed or delivered to the storage temporarily), but the exam might separate those topics (like computing energy stored $= \frac{1}{2}CV^2$ or $\frac{1}{2}LI^2$). For straightforward circuit power, stick to the basics here.

Common exam traps: - Mixing up P, V, I in formulas: A classic slip is using the wrong form unwittingly, like using $P = V^2R$ instead of V^2/R. Always derive from $P = VI$ and $V = IR$ quickly if unsure: substitute $I = V/R$ into $P = VI$ to get $P = V * (V/R) = V^2/R$. Or $V = IR$ into $P = VI$ to get $P = (IR) * I = I^2R$. This derivation reminds you the R is in the denominator for the V-squared form, not numerator.

- **Wrong units or unit conversions:** If voltage is given in kilovolts and current in milliamps, you might do $P = (kV) * (mA)$ without converting – which actually is okay if you realize kVmA *= (1000 V)*(0.001 A) = 1 W, so numerically the product of the numbers gives P in watts directly. But if you get confused, convert everything to base units: Example: 0.5 kV * 20 mA = 500 V * 0.02 A = 10 W. Also watch out for hours vs seconds for energy problems. If a question gives a battery's amp-hour rating and asks for energy or time, you'll need to convert hours to seconds or ensure consistent use of time units.

- **Sign mistakes (delivered vs absorbed):** If the question asks "how much power is delivered by the source" and you compute P = VI using the source's voltage and current, be aware that if you followed passive sign convention from the source's perspective, you might get a negative number (because current enters the negative terminal of an ideal source that's delivering power). For an answer, you'd typically give the magnitude and say "delivered" to clarify. For example, a 12 V battery supplying 2 A to a circuit: $P = 12 * 2 = 24W$. But is that absorbed or delivered? The battery is losing 24 J/s of chemical energy – it's delivering 24 W to the circuit. If you put a positive sign, clarify it's 24 W delivered (or you can say -24 W with passive sign convention meaning deliver). Many exam problems won't require the negative sign explicitly;

they'll just expect you to interpret context. The main trap is consistency: if you label the battery's positive terminal at the top and current leaving it, then P = 12 * (-2 A) = -24 W (negative meaning delivering). If you're not comfortable with that, just find the magnitude and use words to indicate direction of power flow.

- **Forgetting power balance:** In multi-component circuits, sometimes they might ask "verify that energy is conserved" by computing power in each element. A trap could be arithmetic sign errors that make it look like more power is dissipated than source provides. Usually, if you keep track properly, sum of P should equal 0 (taking sign for delivered vs absorbed). If it doesn't, re-check each component's P calculation and sign assignment.

- **Thermal vs electrical units:** Occasionally, a question might blend units, like "a resistor dissipates X watts – how many BTU/h is that?" or something of that nature (since mechanical engineering might involve heating effects). 1 W = 3.412 BTU/h approximately. It's rare but keep in mind if an odd unit appears.

- **Energy vs Power confusion:** Remember, power is the rate, energy is the total amount. If a problem gives a time duration and asks for energy, don't just compute power and stop. Multiply the power (in watts) by time (in seconds) to get energy in joules. Or if using hours and watts, you get watt-hours (divide by 1000 for kilowatt-hours, etc). Common mistake: giving an answer in watts when asked "how much energy was used in 10 minutes?" – the answer needs to be in joules or maybe watt-hours, not just watts.

Exam Handbook Search Cues (Not affiliated with or endorsed by NCEES): "power = VI", "$P = I^2R$", "energy, work, joule, watt-second", "electrical power"

Footnotes:

- The exam handbook lists $P = VI$ and likely the variations under basic electrical relationships. It may also separately list formulas for energy stored in capacitors/inductors, but those are specialized; for pure DC circuit calculations, $P = VI$ is king.

- **Units to remember:** 1 W = 1 J/s. 1 kW = 1000 W. Energy: 1 kWh (kilowatt-hour) = 1000 W * 3600 s = 3.6e6 J. This often comes up in electrical energy consumption contexts. Another: 1 Wh = 3600 J. If a battery is rated in mAh (milliampere-hours), e.g., 2000 mAh at 9 V, that's 2 Ah (since 2000 mA = 2 A) at 9 V. 2 Ah means it can supply 2 A for 1 hour (in theory). The energy capacity in watt-hours is 9 V * 2 Ah = 18 Wh (which is 64,800 J).

- **Resistor power rating:** While not directly likely on FE, just know real resistors have a max power they can safely dissipate (like 1/4 W, 1 W, etc.). If you calculate a resistor is dissipating 5 W and it's a tiny 1/4 W resistor in real life, it'd burn up. On the exam they might ask conceptually what happens if you exceed power rating (resistor overheats, fails). Not a heavy focus, but a practical note. - In purely DC circuits, capacitors and inductors ideally do not dissipate energy – they store it and release it. Over a full cycle in DC (charging then discharging) they can return energy (conservation still holds). But any resistance converts it to heat irreversibly (that's where energy "goes"). So usually the power dissipation in a DC circuit is all in resistors (or other real loads), whereas sources supply that power. - If multiple sources are present, one source might absorb power from another (e.g., two sources fighting or a recharging battery scenario). In that case, you'll get a negative power for one of the sources (meaning it's absorbing energy from the circuit). Just be open to that possibility. The algebraic method with signs will handle it.

- **Efficiency:** Sometimes they might implicitly test power concepts via efficiency: e.g., an electrical machine takes 100 W electrical and outputs 80 W mechanical, efficiency = 80%. The difference 20 W is likely dissipated as heat. That 20 W corresponds to some resistor or internal loss. Efficiency = output power / input power. Just in case a problem is framed in those terms.

- **Temporary vs steady power in L/C:** In DC steady state after a long time, capacitors act as open (no DC current through, so no steady power draw after charged) and inductors act as short (no voltage drop, so no steady power dissipation themselves either). Any energy they took from sources is stored (C as electric field, L as magnetic field). If conditions don't change, that energy stays put. If you then disconnect things or whatnot, that stored energy might discharge (like a spark or so). But that's transient analysis (another topic). For steady DC analysis, you can often ignore capacitor or inductor in terms of continuous power draw (except at the moment of switching).

- **Circuit breaker / fuse thinking:** Overcurrent protection devices often are sized by power indirectly. For instance, too much current means too much I^2R heating in wires, potentially melting insulation. That's all about power dissipation in unintended places. The FE might not directly ask that, but understanding I^2R as heat generation is useful context.

Explanation & Analysis (Step-by-Step): To solve DC power and energy questions, follow a logical approach:

1. **Identify the element(s) of interest:** Is the question about the power in a specific resistor, the power delivered by a source, or total power in a circuit? This tells you where to apply $P = VI$.
2. **Gather or compute V and I for that element:** Often, you need to determine either the voltage across or current through the element from the circuit conditions first. For example, if asked for power in a resistor, you might first solve the circuit to find the current through it or voltage across it (e.g., using voltage division or current division).
3. If the circuit is simple, it might be direct: "a 10 Ω resistor connected across a 5 V source" – here V=5, I=0.5 A, so P=2.5 W.
4. If the circuit is complex, you may need to find those values via analysis techniques from earlier topics (KCL, KVL, Thevenin, etc.). For instance, if it's a resistor in a bridge circuit, find its V or I by solving the network, then multiply.
5. **Choose the power formula that fits best:**
6. If you found the current through a resistor and you know its resistance, using $P = I^2R$ is convenient.
7. If you have the voltage across a device and the current, just do $P = VI$ directly.
8. If you only know voltage across a resistor and its resistance, $P = V^2/R$ is handy (saves an extra step of finding I).
9. All roads lead to the same result, so use the one that minimizes risk of error or extra calc.
10. **Apply sign convention if needed:** Decide if you need to report the power as positive (absorbed) or negative (delivered) in context:
11. For a resistor or any passive load, power will be positive (dissipating) if you plug numbers in straightforwardly (they typically give drop and current in direction of drop).
12. For a source, if you compute $P = VI$ with V being the source's voltage (say 12 V) and I the current leaving the

positive terminal, you'll get a positive number but that actually means the source is *absorbing* power (acting as a load) if you did passive sign convention. To avoid confusion, many prefer to say: If current enters the positive terminal of an element, $P = +VI$ is absorbed by element. For a supply, current often exits the positive terminal (entering from the other side), so you might assign a negative power to indicate delivery. Alternatively, just find the magnitude and state "delivered" in words. For example, a battery with 12 V across it and supplying 2 A out of its positive terminal: $P = 12 * 2 = 24W$. Because current is leaving the positive, we know the battery is delivering 24 W (you could say $P_{battery} = -24W$ by passive sign convention to indicate that).

13. The FE usually isn't overly strict on sign as long as you correctly identify who's delivering or absorbing. However, if a question asks "is the element absorbing or supplying power and how much?", be ready to interpret the sign.
14. **Solve for energy if asked:** If the problem extends to energy:
15. If power P is constant over a time t, then $W = P \times t$. Make sure time is in seconds if you want Joules. If time is given in minutes, convert (e.g., 5 minutes = 300 s). If they want the answer in watt-hours or something, you can use hours in that multiplication to get Wh.
16. If power isn't constant, perhaps the problem provided an average or wants an average. For DC circuits, unless a switch is flipped mid-way, assume constant. If a device's power changes (like a heater has two settings), you might compute energy in each interval separately.
17. Sometimes they'll give an energy (like a battery stored energy or capacity) and ask how long it can last at a certain power draw. Here you invert: $t = W/P$. For example, a battery has 18 kJ of energy, device draws 20 W, how long? $t = 18000J/20J/s = 900s = 15min$.
18. If using amp-hour info: a 12 V, 10 Ah battery theoretically has 120 Wh of energy. If you draw 60 W, it lasts 2 hours (ideal case).
19. **Double-check with conservation if feasible:** In a circuit with multiple elements, you can check that the sum of power in all elements = 0 (taking delivered as negative). For instance, say you have a 10 V source supplying a 5 Ω resistor that draws 2 A. Source: $P = 10V * 2A = 20W$. By passive sign, that's +20 W absorbed by source (meaning -20 W delivered). The resistor: $P = I^2R = 4 * 5 = 20W$ absorbed. So indeed resistor dissipates 20 W, source delivers 20 W, energy is conserved (20 out, 20 in). If you got resistor 20 W and source 20 W both positive, you'd be implying 40 W somehow used which is wrong – the trick is signs: source should be -20 W. So ensure the narrative is correct: one delivers, one uses.
20. **Watch out for trick wording:** Sometimes a question might describe a situation in words: *"A 6 V battery is connected to a lamp. The lamp's resistance is 12 Ω. Determine the power the lamp consumes and the power the battery delivers."* Here, find current: I = 6/12 = 0.5 A. Lamp: $P = V_lamp * I = 6 * 0.5 = 3W$. Battery: $P = V_batt * I = 6 * 0.5 = 3W$. The battery's positive terminal current is leaving, so it's supplying 3 W (you could say -3 W if doing a summation, but in answer, "3 W delivered by battery"). Both numbers are 3, as expected. If you got different values, error.
21. If instead they asked "how much power is dissipated in the 12 Ω resistor?", you might use $I^2R = 0.25 * 12 = 3W$ right away.
22. If they give you a power and ask for another parameter, invert the formula accordingly: e.g. "Resistor has 50 W dissipated and 2 A through it, what's its resistance?" Use $P = I^2R$ rearranged: $R = P/I^2 = 50/(4) = 12.5\Omega$.
23. **Energy usage example:** *"A 100 W lightbulb runs for 2 hours. How much energy is used?"* Compute $W = 100W * (2 * 3600s) = 720000J = 720kJ$. In kWh, that's 0.1 kW * 2 h = 0.2 kWh. Make sure to give what unit they prefer (probably Joules since SI, unless they specifically say kWh).
24. Another style: *"A battery rated at 5 Ah and 12 V is connected to a 6 W device. Approximate how long the battery will last."* Battery capacity in watt-hours = 12 V * 5 Ah = 60 Wh. Device uses 6 W, so ideal time = 60/6 = 10 hours. (In reality, battery capacity might derate under load, but ignore that in ideal calc).
25. **Multiple sources and loads:** If you have, for example, two sources, one might actually be absorbing power from the other. A case: a 12 V source and a 5 V source connected with some resistors could result in current flowing from 12 V source into the 5 V source (charging it, if it were a battery). You could find that the 5 V source has current entering its positive (meaning it's absorbing power, acting as a load). This is fine and consistent with P formulas. The exam might not go into that depth, but just in case, be ready to interpret a negative power outcome logically (it means that device is acting opposite to the assumed passive direction).
26. **Practice common values mentally:** Because quick estimates can sometimes save you: e.g. 12 V * 2 A = 24 W (common for small motors or such), 120 V * 10 A = 1200 W (~1.2 kW, like a heater or hair dryer), 1/4 W resistor burning out if above that, etc. If an answer is wildly off (like you get 1e6 W for a small circuit) you likely miscomputed. Most FE problems keep numbers reasonable – a few watts, maybe hundreds at most in mechanical contexts (unless it's like a large motor problem, but then they usually give horsepower or kW directly).
27. So to wrap up: compute power with $P = VI$ and its siblings confidently, mind your units, and interpret the result in context (who is using power, who is supplying). Then for energy, multiply by time as needed. This is straightforward plug-and-chug once you have the circuit solved for V and I, so the main challenge is often obtaining those correct V and I values from the circuit analysis – which the previous subtopics trained you to do. With that, you ensure you don't leave easy points on the table when a power question comes up on exam day.

Topic 03 - AC Circuit Analysis

Topic Introduction: AC circuit analysis deals with sinusoidal voltages and currents, their phase relationships, and how circuit elements like resistors, inductors, and capacitors behave under alternating current. This is crucial on the FE Mechanical Exam because many mechanical systems (motors, HVAC equipment, generators) involve AC electrical power. By mastering this topic, you'll be ready for typical exam questions such as determining the current through an AC circuit element, combining impedances at a given frequency, or calculating the power factor of a motor and how to improve it. In short, AC analysis lets you **treat oscillating voltages/currents with the same ease as DC**, using complex impedance instead of resistance. Expect problems where you convert a time-domain sinusoid to a phasor, apply Ohm's law with impedance, and compute real, reactive, and apparent power – often to size a capacitor for power factor correction. It matters because a mechanical engineer must ensure electrical components in their systems are efficient and correctly specified (no overheated wires from low power factor, for example!). Let's break down the core subtopics:

K05.T03.S01 – Sinusoidal Signal Characteristics & Phasor Representation

Principle Introduction: AC circuit variables are usually *sinusoidal* (sine or cosine) functions of time. Key characteristics of a sinusoid include its **amplitude**, **frequency**, **period**, and **phase angle**. Rather than working with complicated time functions directly, we use **phasors** – a complex number representation of sinusoids – to simplify analysis. A phasor boils a sinusoidal signal down to two things: its magnitude (related to amplitude) and its phase. This allows differential equations (from inductors and capacitors) to be solved algebraically using Ohm's law in the phasor domain. Important facts and steps for this subtopic:

- **Sinusoidal wave parameters:** If $v(t) = V_{\max}\cos(\omega t + \phi)$ is a voltage signal, $V_{\max}$ is the peak amplitude. The frequency f in hertz is related to the angular frequency ω by $\omega = 2\pi f$. The period T (seconds) is the time for one full cycle, $T = 1/f$. The phase angle ϕ (radians or degrees) shifts the waveform in time (a positive phase means the cosine starts at a value $V_{\max}\cos\phi$ at $t = 0$). A **positive phase** leads the waveform (starting ahead in time), a **negative phase** lags it.
- **Peak vs RMS values:** AC voltages and currents are often given as **RMS (root-mean-square)** values, which is a kind of "effective" amplitude. For any pure sinusoid, $X_{\text{rms}} = \frac{X_{\max}}{\sqrt{2}}$. RMS is used because it directly relates to the power delivered. For example, household "120 V AC" actually means 120 V *RMS*, which corresponds to a peak of about 170 V. The average (mean) value of a symmetric AC sinusoid over a full cycle is zero – it spends as much time positive as negative – but its **RMS value** is positive, indicating effective magnitude. On exam day, if a problem gives "$V = 10$ V AC", assume that's an RMS value unless it explicitly says peak.
- **Phasor concept:** A phasor is a complex representation of a sinusoidal signal *at a given frequency*. We represent $v(t) = V_{\max}\cos(\omega t + \phi)$ as a phasor $V = V_{\max}e^{j\phi}$ (in *peak* form) or $V = V_{\text{rms}}\angle\phi$ (in *RMS* form). The idea is that the time dependence $e^{j\omega t}$ is understood and not written; the phasor V contains only the amplitude and phase information. Phasors let us use algebra instead of calculus: differentiation with respect to time becomes multiplication by $j\omega$, and integration becomes division by $j\omega$. This dramatically simplifies solving AC circuits with inductors and capacitors.
- **Use of cosine reference:** By convention, we use cosine as the reference function for phasors. A sine can always be rewritten as a cosine with a phase shift (since $\sin x = \cos(x - 90°)$). So if you see a sine, convert it to cosine form before forming a phasor. The phasor's angle will adjust accordingly. For example, $i(t) = I_{\max}\sin(\omega t + 30°)$ can be written as $I_{\max}\cos(\omega t + 30° - 90°) = I_{\max}\cos(\omega t - 60°)$, so the phasor would be $I = I_{\max}\angle -60°$.

Equation – Sinusoidal Signal & Phasor Form:

A time-domain sinusoid can be converted to a phasor for steady-state AC analysis. This allows using algebraic methods to solve circuits.
Professional Form: $v(t) = V_{\max}\cos(\omega t + \phi)$
Phasor Representation: $V = V_{\text{rms}}\angle\phi$, where $V_{\text{rms}} = \frac{V_{\max}}{\sqrt{2}}$.

Variables and Units:

- $v(t)$: instantaneous voltage as a function of time (volts, V)
- $V_{\max}$: peak amplitude of the voltage (V)
- ω: angular frequency (radians/second), related to frequency f by $\omega = 2\pi f$
- ϕ: phase angle of the sinusoid (radians or degrees)
- V: phasor voltage (complex, in volts) representing the amplitude and phase of the sinusoid
- V_{rms}: root-mean-square voltage corresponding to the sinusoid (V)

Assumptions and Scope:

- Applies to steady-state single-frequency AC signals (sinusoidal steady state).
- Phasor representation assumes linear circuits with a constant frequency – it is not used for transients or non-sinusoidal waveforms.
- Phase angles can be in degrees or radians; be careful to use consistent units when calculating or when using the calculator's trigonometric functions.

Limit Checks:

- If $V_{\max} = 0$, the phasor is zero (no signal at all).
- If $\phi = 0$, the cosine starts at its maximum at $t = 0$; if $\phi = \pm 90°$, the cosine starts at zero (sine wave start).
- As $f \to 0$ (very low frequency, approaching DC), the sinusoid varies so slowly it's essentially a constant voltage – the phasor method still works (the phasor just becomes a DC value at angle 0 if positive). As $f \to \infty$ (very high frequency), the period $T \to 0$; the phasor representation remains valid, though circuit element behaviors (impedances) will change with ω.

Use vs. Time-Domain Approach: Use phasors instead of time-domain differential equations when analyzing linear AC circuits at steady state. For example, use this phasor form

plus Ohm's law $V = IZ$ to find current, rather than solving $L\frac{di}{dt} + \frac{1}{C}\int idt + Ri = v(t)$ directly. Phasors *cannot* be used if the problem involves aperiodic or transient behavior (like an RC charging curve) – those require time-domain analysis or Laplace transforms.

Common Exam Traps:

- **Dropping RMS/Peak factor:** Make sure you know whether you're using peak or RMS values in your calculations. If a phasor is defined with RMS magnitude (common in power calculations), then when converting back to time domain, multiply by $\sqrt{2}$ to get the peak for $V_{\max}\cos(\omega t + \phi)$. Forgetting this conversion or using peak values in a formula that assumes RMS (like power formulas) will result in errors.

- **Degree vs Radian confusion:** If you plug an angle into $\cos(\omega t + \phi)$ or into your calculator, ensure you're in the correct mode. An answer could be off wildly (cosine of 30 radians is not the same as cosine of 30 degrees!).

- **Sign conventions:** A leading phase (e.g. +30°) vs lagging (–30°) can be confusing. Remember that if a current phasor has a positive angle relative to a reference voltage phasor, the current *leads* (comes earlier in time). If it has a negative angle, it *lags*. It's easy to accidentally invert lead/lag descriptions.

Exam Handbook Search Cues (Not affiliated with or endorsed by NCEES): *frequency*, *period*, *angular frequency*, *sinusoidal*, *RMS*, *phasor*, *phase angle*, *cosine*

Footnotes:

- *Units:* In AC calculations, always express angles in **radians** when using $\omega = 2\pi f$ (since ωt expects radians). If frequency is given in hertz, compute ω in rad/s before plugging into impedance formulas or the $e^{j\omega t}$ phasor factor.

- *Phasor notation:* Engineers use j for $\sqrt{-1}$ (instead of i) to avoid confusion with current $i(t)$. A phasor like $5\angle 30°$ could also be written as $5e^{j30°}$ or $5(\cos 30° + j\sin 30°)$. All represent the complex number 5 at an angle of 30°.

- *Context:* Mechanical FE problems involving AC typically stick to a single frequency (no changing frequency during a problem). So once you identify f or ω for the scenario, you'll use that throughout the solution.

Variations and Related Forms:

- **Sine waves vs cosine:** A sine can be treated by converting to cosine with a phase shift (as noted above). E.g. $I_{\max}\sin(\omega t) = I_{\max}\cos(\omega t - 90°)$. Don't hesitate to rewrite a sine as a cosine for phasor use.

- **Rectified waveforms:** While not as common on the FE Mechanical, note that if you ever needed the RMS of a full-wave rectified sine, it's the same as the original AC RMS (because flipping negative halves positive doesn't change the effective value). The average of a full-wave rectified sine is $2V_{\max}/\pi$, whereas a pure sinusoid's average is 0. These facts could be relevant if a question involves a rectifier or similar circuit.

- **Typical values:** Most power systems use 50 Hz or 60 Hz AC. In the exam, if a "power line" or wall outlet context appears, you can infer $f \approx 60$ Hz in the U.S. (50 Hz in some other countries). Also $2\pi f \approx 377$ rad/s at 60 Hz. Familiarity with these numbers can help verify your calculations.

Special Notes: For calculator use, you can often solve phasor problems by converting to rectangular form. For example, to add $10\angle 30° + 5\angle -90°$, you might convert each to $(x + jy)$ form on scratch paper or use the complex mode of your calculator. The Casio fx-115/991 series and TI-36X Pro can directly handle polar/rectangular conversions, which saves time. Practice entering values like $12\angle 40°$ (as $12\exp(j40°)$ or using the angle symbol) into your specific calculator **before** exam day.

Explanation & Analysis: Let's interpret the sinusoidal voltage expression piece by piece. The form $v(t) = V_{\max}\cos(\omega t + \phi)$ tells us a lot:

- $V_{\max}$ is the **peak voltage**. If $V_{\max} = 10$ V, the waveform swings from +10 V at its highest to –10 V at its lowest (assuming a centered sinusoid). Engineers often care about the **RMS voltage** $V_{\text{rms}} = V_{\max}/\sqrt{2}$ because a 10 V peak AC would deliver the same power to a resistor as a 7.07 V DC source. Always clarify whether a given magnitude is peak or RMS. Many AC meters (and exam problems) directly provide the RMS value by default.
- ωt is the argument of the cosine in radians. The product ωt increases linearly with time, causing the cosine to oscillate. ω by itself is the **angular frequency** in rad/s; it tells how fast the waveform cycles. For example, $\omega = 377$ rad/s corresponds to $f = 60$ Hz. A higher f or ω means more cycles per second (shorter period T). On the exam, you might be given f and need to compute ω for use in component impedance formulas (coming up in the next subtopic). Always use ω in those formulas – a common mistake is to plug f where ω is needed.
- ϕ is the **phase angle** of the voltage. It shifts the wave left or right in time. If $\phi > 0$, the cosine wave is shifted to the left (it reaches its peak earlier than a zero-phase cosine). If $\phi < 0$, the wave is delayed (shifted to the right). Phase differences are crucial in AC circuits: the phase difference between voltage and current of a circuit element tells us if the element is storing energy (inductor or capacitor) or dissipating it (resistor). For instance, if a current is **90° out of phase** with a voltage, there is no net energy transfer on average – this is pure reactive behavior.
- The phasor $V = V_{\text{rms}}\angle\phi$ is a **stationary representation** of that oscillating voltage. Think of it as an arrow in the complex plane: its length is V_{rms} and it is angled at ϕ from the horizontal axis. As time progresses, the actual voltage $v(t)$ is like the vertical projection of this rotating arrow (rotating at ω rad/s). This analogy can help your intuition – the arrow's shadow on a wall goes up and down like a cosine wave. By working with the arrow (phasor) itself, you bypass the oscillation and just deal with its static magnitude and angle. **Bottom line:** use phasors to convert differential equations into simple algebra. Once you solve for a phasor voltage or current, you can convert back to a time-domain answer if needed by plugging it into $X_{\max}\cos(\omega t + \phi)$.

- **Example Analysis:** Suppose you have a voltage source $v_s(t) = 170\ \text{V}\cos(120\pi t)$ supplying an AC circuit (120π rad/s is 60 Hz). The source's RMS voltage is $170/\sqrt{2} = 120$ V. If the source has no phase shift (0°),

its phasor is $V_s = 120\angle 0°$ V. If a load current is measured as $i(t) = 5\text{ A}\cos(120\pi t - 30°)$ (5 A peak, 60° lagging behind the voltage), the current phasor would be $I = 5/\sqrt{2}\angle -30° = 3.535\angle -30°$ A. We immediately see the current's phase is -30°, meaning *current lags voltage by 30°*, typical of an inductive load. With phasors, we can now multiply/divide complex numbers to find impedances or other quantities without writing any sines or cosines beyond this point.

K05.T03.S02 – Impedance and Admittance in AC Circuits

Principle Introduction: In AC steady-state analysis, each circuit element (R, L, or C) is characterized by a complex impedance Z that relates its phasor voltage and current: $Z = V/I$. Impedance is the AC analogue of resistance. Like resistance, it's measured in **ohms (Ω)**, but unlike pure resistance, impedance can have a phase angle (it can be complex). The real part of impedance is resistance R (dissipates energy as heat), and the imaginary part is reactance X (stores and returns energy each cycle). A **positive reactance** (+jX) is inductive and causes current to lag voltage; a **negative reactance** (–jX) is capacitive and causes current to lead voltage. The inverse of impedance is **admittance** $Y = 1/Z$, measured in **siemens (S)**, which is similarly complex (with conductance G as the real part and susceptance B as the imaginary part). For solving circuits, we combine impedances using the same rules as resistors: impedances add in series, and admittances add in parallel. Key points:

- **Resistor (R):** An ideal resistor's impedance is purely real: $Z_R = R$ (ohms). It does not cause any phase difference between voltage and current. In phasor form, if $V = IZ_R$ and $Z_R = R$ (a real number), then the voltage and current phasors are in phase (angle 0 difference). Admittance of a resistor is $Y_R = 1/R$ (siemens), purely real as well.
- **Inductor (L):** An inductor's impedance is $Z_L = j\omega L$. This is purely imaginary positive (since j corresponds to +90° phase). In practical terms, the inductor's voltage leads its current by +90°. The magnitude of inductive reactance is $X_L = \omega L$ (Ω). Higher frequency or larger inductance means a bigger reactance (it's harder for high-frequency AC to push current through an inductor). The admittance of an inductor is $Y_L = 1/(j\omega L) = -j/(\omega L)$. That negative imaginary admittance means it's like a capacitive susceptance in sign (since adding an inductor to a circuit is like subtracting susceptance).
- **Capacitor (C):** A capacitor's impedance is $Z_C = \frac{1}{j\omega C} = -\frac{j}{\omega C}$. This is purely imaginary *negative* (–j), indicating the capacitor's current leads its voltage by 90° (or voltage lags current by 90°). The magnitude of capacitive reactance is $X_C = \frac{1}{\omega C}$ (Ω). Notice that at higher frequency, X_C gets smaller – a capacitor is easier for high-frequency AC to pass through, but it blocks DC (at $\omega = 0$, $X_C \to \infty$ Ω, an open circuit). The admittance of a capacitor is $Y_C = j\omega C$, a positive imaginary susceptance.
- **Combining impedances:** The combination laws mirror those for resistors because impedance is effectively "generalized resistance." For components in **series**, you simply add their impedances: $Z_{\text{eq(series)}} = Z_1 + Z_2 + \cdots$. For components in **parallel**, you add the inverses (admittances): $Y_{\text{eq(par)}} = Y_1 + Y_2 + \cdots$, and then take $Z_{\text{eq}} = 1/Y_{\text{eq}}$. In formula form, for two impedances in parallel: $Z_{\text{eq}} = \frac{1}{\frac{1}{Z_1}+\frac{1}{Z_2}}$. These relationships hold for complex values just as for reals. Be cautious when adding impedances: you must add them as complex numbers (which may involve combining real and imaginary parts). It's often convenient to express each impedance in rectangular form (R + jX) when adding in series, or express each admittance in rectangular form (G + jB) when adding in parallel.
- **Ohm's Law in AC:** The familiar $V = IR$ generalizes to **phasor form**: $V = IZ$. This is used per element or for the circuit as a whole (after finding an equivalent impedance). Kirchhoff's voltage and current laws (KVL and KCL) also apply in the phasor domain: the sum of voltage drops around a loop is zero, and the sum of phasor currents at a node is zero (conservation of charge still holds, just treat complex currents algebraically). Solve AC circuits by replacing every R, L, C with its impedance, then use the same circuit analysis techniques (Ohm's law, voltage division, current division, nodal analysis, etc.) as you would for DC circuits. Finally, convert any phasor results back to time domain if required.

Equation – Impedance & Admittance Definitions:
Impedance Z relates phasor voltage to phasor current ($Z = V/I$), and admittance Y is its reciprocal. These let us extend Ohm's law to AC circuits.

Formulas:

$Z = R + jX$, with $Z = \frac{V}{I}$ in phasor form (Ohm's law).
$Y = G + jB$, with $Y = \frac{1}{Z} = \frac{I}{V}$.
(For a given circuit element or network, R is the equivalent resistance, X the equivalent reactance, G the equivalent conductance, and B the equivalent susceptance.)

Variables and Units:

- Z: impedance (ohms, Ω). A complex number in general.
- R: resistance, the real part of Z (Ω). If $Z = R$ (no imaginary part), the element is purely resistive.
- X: reactance, the imaginary part of Z (Ω). $X = X_L - X_C$ effectively, combining inductive and capacitive effects. Positive X means net inductive, negative X means net capacitive.
- Y: admittance (siemens, S). Also complex in general, $Y = 1/Z$.
- G: conductance, the real part of Y (S). For a resistor, $G = 1/R$.
- B: susceptance, the imaginary part of Y (S). $B = -1/X$ for a single reactance (negative for inductors, positive for capacitors).
- V, I: phasor voltage (V) and current (A) through the circuit element or equivalent.

Assumptions and Scope:

- We assume linear, time-invariant circuit elements at a single AC frequency. Impedance can be used for capacitors and inductors only under steady sinusoidal excitation (not during startup transients or frequency sweeps).

- The formulas above treat R, X, G, B as lumped element parameters. This is valid for circuit components; for distributed systems (transmission lines, etc.), more complex

frequency-dependent models exist, but those are beyond FE exam scope except perhaps a mention of line impedance.

- Sign convention: The sign of X or B is important. By passive sign convention, if $Z = +jX$ (positive imaginary), the element is inductive; if $Z = -jX$ (negative imaginary), the element is capacitive.

Limit Checks (Sanity Tests):

- At $\omega = 0$ (DC): $Z_L = j0 \cdot L = 0\ \Omega$ (an inductor behaves like a short circuit at steady DC), and $Z_C = 1/(j0 \cdot C) = \infty\ \Omega$ (a capacitor is an open circuit at DC). These limiting cases are handy to remember for checking circuits in extreme conditions.

- At $\omega \to \infty$ (very high frequency): $Z_L \to j\infty$ (inductor becomes an open circuit for fast-changing signals), and $Z_C \to 0$ (capacitor becomes like a short at very high frequency). If an exam question asks what happens as frequency increases or decreases, use these limits to double-check your reasoning.

- If you set $L = 0$ or $C = \infty$ (removing those elements), their impedances effectively disappear (inductor becomes 0 Ω, capacitor becomes ∞ Ω), which should bring you back to familiar resistor-only circuits.

Combining Impedances – Quick Reference:

- Series: $Z_{\text{eq}} = Z_1 + Z_2 + \cdots + Z_n$. (Add the complex numbers directly.)
- Parallel: $Y_{\text{eq}} = Y_1 + Y_2 + \cdots + Y_n$, then $Z_{\text{eq}} = 1/Y_{\text{eq}}$. For two in parallel, $Z_{\text{eq}} = \frac{Z_1 Z_2}{Z_1 + Z_2}$ (just like the product-over-sum for two resistors in parallel).

Use vs. Sibling Concepts:

- Use impedance in AC analysis instead of using resistance alone. For DC circuits, resistance was enough; for AC, replace every R with Z to include L, C effects. **Do not** mix time-domain formulas (like $v = Ldi/dt$) directly with phasors – convert those into impedance first (e.g. $j\omega L$).
- Admittance is just the reciprocal viewpoint – it might simplify analysis of parallel circuits or nodal analysis. Use whichever form makes the math easier. For instance, to find the parallel combo of a capacitor and inductor, summing their admittances $j\omega C + 1/(j\omega L)$ is often easier than computing the product-over-sum in impedance form.

Common Exam Traps:

- **Missing the j:** Students sometimes write an inductor's impedance as just ωL or a capacitor's as $1/\omega C$. Don't drop the j! Without it, you're missing the phase information. $j\omega L$ means the voltage leads current by 90°; if you wrote ωL (as if it were a resistor), you'd be implying they're in phase, which is wrong.

- **Using f instead of ω:** As noted earlier, if a problem gives frequency f, you must convert to angular frequency $\omega = 2\pi f$ for impedance formulas. For example, if $f = 60$ Hz, then $X_L = \omega L = 2\pi(60)L \approx 377L$. Using 60 instead of 377 would under-calculate the reactance by a factor of 2π.

- **Unit conversion errors:** Inductance might be given in mH, capacitance in µF. Convert to henrys and farads before plugging numbers. Also, if using $X_C = 1/\omega C$, ensure ω is in rad/s.

- **Phasor algebra mistakes:** When adding impedances (especially more than two), it's easy to make arithmetic mistakes with complex numbers. Write them in $R + jX$ form and combine real and imaginary parts separately. A common error is to add magnitudes instead of complex numbers – e.g., treating $5 + j5$ and $5 - j5$ as if they'd sum to 10 somehow. In fact, $5 + j5 + 5 - j5 = 10 + j0$. Keep track of the imaginary unit.

- **Interpreting results:** If you compute a total impedance and get a complex number like $8 - j6\ \Omega$, remember that means the circuit is partially resistive (8 Ω of resistance) and partially capacitive (reactance –6 Ω). The negative imaginary part means a net leading current (capacitive behavior). Always consider whether that result makes sense for the given circuit (e.g., if you had more capacitance than inductance, a net –jX result is expected).

Exam Handbook Search Cues (Not affiliated with or endorsed by NCEES): *impedance*, *admittance*, *reactance*, *susceptance*, *ohm's law*, *series*, *parallel*, *RLC circuits*

Footnotes:

- *Reactance sign conventions:* We often denote $X_L = \omega L$ and $X_C = 1/(\omega C)$ as the magnitudes of inductive and capacitive reactance (which are always positive numbers). When writing the impedance, we include the sign via j or $-j$. For example, one might say "the capacitor has reactance $X_C = 20\ \Omega$" meaning its magnitude, but write the impedance as $Z_C = -j20\ \Omega$. Just be clear on context: X (no j) usually implies you're talking about the scalar magnitude of reactance.

- *Frequency dependence:* Note how Z_L and Z_C depend on ω. This means if the frequency changes, the impedance of L or C changes. In exam problems, if you see multiple cases with different frequencies, recalculate X_L, X_C for each case.

- *Quality of components:* Real inductors and capacitors have some resistance too (e.g., coil winding resistance or dielectric loss). The FE exam generally ignores these unless explicitly given, treating components as ideal. If you see a small resistor in series with an inductor in a diagram, that's accounting for a real inductor's internal resistance – but if not mentioned, assume ideal components (zero resistor in series with L, infinite resistor (open) in parallel with C).

- *Units:* 1 siemens (S) is $1/\Omega$. Sometimes older literature uses mho (℧) as the unit for admittance. It's rarely seen on the exam, but 1 mho = 1 S.

Variations, Related Forms, Typical Values:

- **Element impedance summary:** For an ideal resistor, $Z_R = R$ and $Y_R = 1/R$. For a capacitor, $Z_C = \frac{1}{j\omega C}$ and $Y_C = j\omega C$. For an inductor, $Z_L = j\omega L$ and $Y_L = \frac{1}{j\omega L}$. Keep these standard relationships at your fingertips; they appear in any introductory circuits reference

- **Phase relationships:** For a resistor, V and I are in phase (0° phase difference). For an inductor, V leads I by 90° (or say I lags V by 90°). For a capacitor, V lags I by 90° (or I leads V by 90°). A mnemonic is *ELI the ICE man*: E (voltage) Leads I in an inductor (L), I Leads E in a capacitor (C). If a problem asks which reaches its peak first, the mnemonic can help.

- **Resonance:** In circuits with both L and C, there is a frequency at which their reactances cancel: $\omega_0 = \frac{1}{\sqrt{LC}}$ (the **resonant frequency** in rad/s). At this frequency, $X_L = X_C$, so an inductor and capacitor in series will behave purely resistively (their j terms sum to zero), and in parallel will theoretically have infinite impedance (they exchange energy back and forth with no net draw from the source). Resonance might be more a topic in electrical depth, but mechanical examinees should know the concept in case of a question about filtering or tuned circuits.

- **Typical values in power systems:** A "large" inductance or capacitance can give surprisingly small reactance at 60 Hz. For example, $L = 0.1$ H gives $X_L \approx 37.7\ \Omega$ at 60 Hz, while $C = 100\ \mu$F gives $X_C \approx 26.5\ \Omega$. Many motor inductances are on the order of tens to hundreds of mH. Capacitors used for power factor correction might be in the tens of microfarads for small motors (to counteract those inductive reactances).

- **Admittance in parallel circuits:** If you have multiple branches, it might be faster to calculate each branch's admittance Y (like conductance for resistors, plus j susceptance for any L or C) and add them. For instance, suppose a branch has a 50 Ω resistor in series with a 0.1 H inductor at 60 Hz; it's not purely parallel, so you can't just add directly, but if it were separate parallel branches (one branch a resistor, one branch an inductor), you'd add $1/50 + 1/(j\omega L)$. Use admittances when dealing with parallel *impedances* that are easier to sum in reciprocal form. This is more of a technique than a new formula, but worth mentioning as variation in approach.

Special Notes: When using your FE exam-approved calculator for AC circuit problems, remember that you can often input complex numbers. For example, on the HP 35s, you might enter a complex impedance as (R, X) in rectangular form. On the TI-36X Pro, you can use the complex mode (a + bi) to add or invert impedances. However, **be mindful of the format**: some calculators expect degrees for the argument if you're in degrees mode. If you're doing polar form like $magnitude\angle\theta$, ensure the calculator knows whether that angle is degrees or radians. A quick check is to see if $\angle 90$ yields an imaginary unit or not. Practice converting a couple of known values (like $5\angle 90°$ should give $5j$ on your calculator) so you don't accidentally mix up angle units during the exam.

Explanation & Analysis: Impedance ties together the properties of resistors, inductors, and capacitors:

- A **resistor** with $Z = R$ means $V = IR$. If 2 A flows through a 5 Ω resistor, the voltage across it is 10 V (just like DC). There's no frequency dependence or phase shift – resistors treat AC and DC the same way in terms of proportionality between V and I. The energy is dissipated as heat. In a circuit problem, resistors are often the easy part: handle them as you always have. If the only elements were resistors, AC analysis would be no different from DC (except you might be dealing with RMS values for power calcs).
- An **inductor** with $Z = j\omega L$ is trickier: say $L = 0.2$ H and the current phasor through it is $I = 3\angle 0°$ A at 60 Hz ($\omega \approx 377$ rad/s). Then $Z_L = j(377)(0.2) = j75.4\ \Omega$. By Ohm's law, $V = IZ = 3\angle 0° \times 75.4\angle 90° = 226.2\angle 90°$ V. In the time domain, that corresponds to a voltage $v_L(t) = 226.2\sqrt{2}\cos(377t + 90°)$ if the current was $i(t) = 3\sqrt{2}\cos(377t)$. That 90° phase lead of voltage over current is the key aspect: an inductor "resists" change in current, causing the voltage to peak a quarter cycle before the current does. The higher the frequency, the greater the opposition (reactance) – imagine rapidly changing current through an inductor, it induces a strong voltage (Faraday's law) opposing that change.
- A **capacitor** with $Z_C = -j/\omega C$ has the opposite behavior: current leads voltage by 90°. If $C = 100\ \mu$F and we apply a phasor voltage $V = 10\angle 0°$ V at 60 Hz, $\omega = 377$ rad/s, then $Z_C = -j/(377 \cdot 100 \times 10^{-6}) = -j26.5\ \Omega$. Current phasor $I = V/Z = 10\angle 0°/26.5\angle -90° = 0.377\angle +90°$ A. That means $i(t) = 0.377\sqrt{2}\cos(377t + 90°)$ while $v(t) = 10\sqrt{2}\cos(377t)$. The current hits its peak a quarter cycle before the voltage does – a capacitor draws the most current when the voltage is changing fastest (voltage zero crossing), and it stops drawing current when the voltage is at a peak (zero change). In practical terms, a capacitor *supplies* reactive power (leading current), whereas an inductor *absorbs* reactive power (lagging current).
- When combining these elements, treat their impedances like resistors but carry through the complex arithmetic. For example, consider a series R-L circuit: $R + jX_L$ is the total Z. The magnitude $|Z| = \sqrt{R^2 + X_L^2}$ gives the ratio of voltage magnitude to current magnitude, and the angle $\theta_Z = \arctan\left(\frac{X_L}{R}\right)$ tells how much the voltage leads the current (since positive angle). If $R = 10\ \Omega$ and $X_L = 10\ \Omega$, the total impedance is $10 + j10 = 14.14\angle 45°\ \Omega$. A current of $5\angle 0°$ A would produce a voltage drop of $5 \times 14.14\angle 45° = 70.7\angle 45°$ V. That 45° phase difference is a mix of resistive and inductive behavior. On the exam, you might be asked for the magnitude of current or the phase angle given such a circuit – just compute it from the phasors. Often a question might present a circuit and ask something like "what is the power factor seen by the source?" which essentially means "what's the angle of the total impedance?" (more on power factor next).
- **Tip:** If you're ever unsure, break the problem into steps: (1) Convert everything to impedances, (2) simplify the circuit (series/parallel combinations), (3) use Ohm's law or voltage divider, etc., to find the desired quantity, (4) convert back to a time-domain answer if needed. For instance, to find the current through a capacitor in series with a resistor given a sinusoidal source, find $Z_{\text{series}} = R + Z_C$, then $I = V_{\text{source}}/Z_{\text{series}}$. The magnitude of I and its phase relative to V_{source} fall right out of that calculation.
- **Check extremes:** If something seems off, test the extreme frequency cases mentally. If you plug $\omega = 0$ (DC) in your result, does the circuit behave as it should? (Capacitors open, inductors short, etc.) If $\omega \to \infty$, do inductors become huge impedance? This can catch errors like mistakenly inverting j (e.g., writing $Z_L = 1/(j\omega L)$ by accident – which would give the opposite behavior). Always keep the physical intuition: inductors resist high-frequency changes (so high ω means big impedance), capacitors pass high frequency (so high ω means small impedance). If your math result violates that, recheck the algebra.

K05.T03.S03 – Power Factor and Correction

Principle Introduction: Power factor (pf) describes the relationship between real power and apparent power in an AC

circuit. It is defined as pf $= \cos\phi$, where ϕ is the phase angle between the voltage and current phasors. Real power P (in watts) is the portion of power that does useful work (like turning a motor or heating something). Reactive power Q (in volt-amps reactive, VAR) is the oscillating power that flows back and forth, stored and released each cycle by inductors and capacitors (like the magnetic field in a motor's coils or electric field in a capacitor). **Apparent power S** (measured in volt-amperes, VA) is the product of RMS voltage and RMS current, $S = VI$, without accounting for phase angle; it represents the "total" power drawn as seen by the source. These three are related by the power triangle: $S^2 = P^2 + Q^2$, where $P = S\cos\phi$ and $Q = S\sin\phi$. Power factor is essentially P/S, the fraction of the apparent power that is actually doing real work. A **power factor of 1.0 (or 100%)** is ideal – it means all the current is contributing to real work (voltage and current in phase, so no reactive component). A low power factor (like 0.6) means a lot of current is circulating just to support reactive fields, wasting capacity in the wires and source.

On the FE exam, you might be asked to compute power factor given P and S or given an impedance's phase angle, or to determine the effects of adding a capacitor to improve power factor. **Power factor correction** typically means adding capacitors for loads with a lagging power factor, or inductors for loads with a leading power factor, to offset the load's reactive power and move the overall power factor nearer to 1. For mechanical engineers, the classic scenario is an induction motor (which is inductive, hence pf lagging) corrected by adding a capacitor bank in parallel. This reduces the phase angle ϕ between the line current and voltage, lowering the current draw for the same real power.

- **Leading vs Lagging:** If current **leads** voltage (ϕ is negative from voltage to current), we say the power factor is *leading*. This typically means a capacitive load (capacitor or an over-corrected system). If current **lags** voltage (ϕ positive, current comes later), the power factor is *lagging* – typical for inductive loads (motors, inductors). The exam may phrase a question like "a motor operates at 0.8 lagging power factor" – you should interpret that as $\cos\phi = 0.8$ with current lagging, so the load is inductive with $\phi = \cos^{-1}(0.8) \approx 36.87°$. Conversely, "0.8 leading" would imply a capacitive load of the same angle but current leads voltage.
- **Calculating Power Components:** Given any two of P, Q, S or pf, you can find the others. For example, if a load draws $P = 5$ kW at pf = 0.85 (lagging), then $\cos\phi = 0.85 \Rightarrow \phi \approx \cos^{-1}(0.85)$. The apparent power is $S = P/\text{pf} = 5000/0.85 \approx 5882$ VA. Reactive power is $Q = S\sin\phi = 5882 * \sin(\cos^{-1}0.85)$. Instead of calculating ϕ explicitly, notice $\tan\phi = Q/P$, so $Q = P\tan\phi$. Using $\tan\phi = \sqrt{1/\cos^2\phi - 1} = \sqrt{1/0.85^2 - 1} \approx 0.619$. Then $Q \approx 5000 * 0.619 \approx 3095$ VAR. This reactive power is positive (inductive) since it's lagging pf. If it were a leading pf case, the same magnitude of Q would be negative (meaning the load actually supplies reactive power back to the source, as a capacitor does).
- **Power Factor Correction:** To improve pf, we want to reduce $|Q|$ (the magnitude of reactive power) drawn from the source. For a lagging (inductive) load, this means adding a capacitance that provides a leading reactive component Q_C to cancel part of the inductive Q_L. Ideally, you add just enough capacitor so that $Q_{\text{net}} = Q_L + Q_C = 0$ (fully corrected to pf = 1). In practice, utilities often correct to something like 0.95 to 0.98 to avoid over-correction. On the exam, if they ask how to correct power factor, they might give you the initial pf and desired pf or ask for the required reactive power compensation. A key formula in such calculations: $Q_C = P(\tan\phi_{\text{initial}} - \tan\phi_{\text{desired}})$**.** This gives the reactive power (in VAR) that the capacitor must supply (it comes out positive for a needed capacitor since initial $\tan\phi$ for lagging is positive and desired tan is smaller or zero). Once you know Q_C, you can find the required capacitance: since $Q_C = V^2\omega C$ for a capacitor on a single-phase line (derived from $I_C = \omega CV$ and $Q = VI$ for 90° phase difference), you get $C = Q_C/(V^2\omega)$. Make sure to use the **line voltage and angular frequency** appropriate for the situation (if it's three-phase, do per-phase calcs carefully or use three-phase power formulas). Often, the exam simplifies by giving you Q or asking for Q directly rather than making you compute C, but it's good to know the relationship.

Equation – Power Factor and Power Relationships:
Power factor is the cosine of the phase angle between voltage and current. It links real and apparent power.
Formula: pf $= \cos\phi = \frac{P}{S}$, where $P = VI\cos\phi$ and $Q = VI\sin\phi$.

Variables and Units:

- **pf:** unitless ratio (between 0 and 1, sometimes expressed as a percentage) indicating power factor.
- ϕ: phase angle between the voltage and current phasors (degrees or radians). It is also the angle of the impedance (if looking from source to load).
- P: real (active) power, measured in watts (W). This is the average power actually consumed or delivered to do work.
- Q: reactive power, measured in volt–amperes reactive (VAR). This represents the oscillating power that is exchanged between reactive components and the source. Positive Q conventionally means net inductive (reactive power drawn from source), negative Q means net capacitive (reactive power returned to source).
- S: apparent power, measured in volt–amperes (VA). $S = V_{\text{rms}}I_{\text{rms}}$. It is the magnitude of the complex power $S = P + jQ$.
- V, I: RMS voltage (V) and current (A) magnitudes, respectively. (Use RMS values in all AC power formulas unless explicitly told otherwise.)

Assumptions and Scope:

- Applies to sinusoidal steady-state AC power. In non-sinusoidal (harmonic) scenarios, power factor is more complex (there's displacement vs distortion power factor), but the FE exam sticks to the basic sinusoidal definition.

- This formula is for single-phase or per-phase of balanced three-phase. In three-phase systems, you often calculate per-phase and then multiply appropriately, but the power factor concept remains the same ($pf = P_{total}/S_{total}$ as well).

- Sign of ϕ (lead or lag) isn't captured by cos (since cos is even). So pf is often stated as "0.85 lagging" instead of just 0.85, to convey the direction of phase. The magnitude is 0.85 either way, but "lagging" tells you $Q > 0$ (inductive load) whereas "leading" means $Q < 0$ (capacitive load).

Limit Checks:

- If $\phi = 0°$, then $\cos\phi = 1.0$. This is a perfect power factor (all the power is real, none is reactive). That would be a purely resistive load. The triangle collapses to a line along P with Q = 0.

- If $\phi = 90°$, then $\cos\phi = 0$. This means P = 0, Q is nonzero – a purely reactive scenario (like an ideal inductor or capacitor with no resistance). In this case, the current is 90° out of phase with voltage, and no real work is done (P=0). The apparent power S is equal to Q in magnitude.

- Most practical loads have $0 < \cos\phi < 1$. For example, a lightly loaded motor might be 0.6–0.7 lagging (quite a bit of reactive draw), while a well-loaded or corrected motor could be 0.9+ lagging. On the FE exam, you can assume power factor will be given as a magnitude between 0 and 1 (with 'leading' or 'lagging' indicating direction). You won't see pf values greater than 1, and any sign information is usually communicated by the words 'leading' or 'lagging' rather than by a negative number.

Use vs. Alternative Approaches:

- Use the power factor and power triangle to split power into P and Q when needed. For instance, if a problem gives total apparent power and a pf, use $P = S\cos\phi$ and $Q = S\sin\phi$ to find the components. This is easier and less error-prone than using time-domain integrals or something to find average power. The concept of pf replaces having to integrate $p(t) = v(t)i(t)$ over a cycle – which the exam doesn't expect you to do, given the reference handbook provides these relationships.

- If an exam question involves energy loss or utility billing, note that utilities charge based on real energy (kWh) but may impose penalties for low power factor because it means wasted capacity. The solution might involve raising the pf to reduce current – e.g., "What size capacitor (in VAR or μF) is needed to raise pf from 0.8 to 0.95 for a 50 kW load?" In such cases, use the difference in Q as outlined and solve for the capacitor.

Common Exam Traps:

- **Forgetting to use RMS values:** The formulas $P = VI\cos\phi$ and $S = VI$ assume V and I are RMS. If you accidentally plug peak values, you'll overestimate P and S by a factor of 2. Always confirm whether a given voltage or current is RMS. Most often it is, but watch for wording like "maximum" or "peak".

- **Misidentifying φ:** Be clear whether φ is defined as the angle of the impedance or the current relative to voltage. Usually in power factor context, $\varphi = \theta_V - \theta_I$(the voltage phase minus current phase). Thus for inductive (lagging) loads, φ is positive (voltage leads current), and for capacitive (leading) loads, φ is negative (voltage lags current). Some students get turned around on this and plug in the wrong sign. One way to remember: an inductive load has a *lagging* current, which is described as positive φ (e.g., 30°), but you might also hear "the load has a 30° lag". The cos doesn't care about sign, but when you add a capacitor for correction, you do need to use the proper signs for Q values (subtract the capacitive Q).

- **Unit confusion:** P is in watts, Q in VAR, S in VA. Numerically, a VA or VAR is handled like a watt in calculations (they add via vector not directly), but when reporting answers, use the correct unit. If a question asks for reactive power, don't give the answer in watts or neglect to specify VAR.

- **Over-correcting power factor:** If you add too much capacitance, you can flip the situation to a leading power factor. The exam might ask what happens if someone oversized the capacitor. The result would be a leading pf, which can be just as problematic (e.g., overvoltage issues). Recognize that there is such a thing as *too much* correction – pf of exactly 1 is ideal, but beyond that you're just sending reactive power the other way. In calculations, over-correction would show up as a negative net Q required from the source (meaning the source sees a capacitive load).

Exam Handbook Search Cues (Not affiliated with or endorsed by NCEES): *power factor*, *real power P*, *reactive power Q*, *apparent power S*, *power triangle*, *VAR*, *leading/lagging*, *power factor correction*, *capacitor*

Footnotes:

- *Analogy:* A common analogy for power factor is a mug of beer: the beer is real power P (the useful part that quenches thirst), the foam is reactive power Q (it occupies space but doesn't do useful work), and the mug's total contents is apparent power S. A low power factor (lots of foam) means you're drawing more current (bigger mug) for the same real benefit (beer). Power factor correction is like scraping off the excess foam so you can get more beer in without needing a bigger mug.

- *Three-Phase Note:* In a balanced three-phase system, power factor is defined similarly, but $P = \sqrt{3}V_L I_L \cos\phi$ for line quantities, etc. The concept and cosφ value are the same whether you use per-phase or total values. Just be consistent. The exam may include three-phase power factor in a question, so remember that the phi is typically given between line voltage and line current angle.

- *Reactive sign convention:* In power systems, by convention, **lagging power factor (inductive)** is often denoted as +Q (positive reactive power), and **leading (capacitive)** as -Q. Some formula references might implicitly assume that, so be cautious interpreting a "+jQ" in a power expression as inductive Q consumption. In circuit analysis problems, you can simply keep track by understanding the physical behavior (e.g., if you add a capacitor, you know it supplies reactive power, thus it will subtract from the total Q needed from the source).

- *Efficiency vs Power Factor:* Don't confuse power factor with efficiency. Efficiency is output power over input power (a ratio < 1), whereas power factor is real power over apparent power. A motor might be 90% efficient (meaning 10% of electrical input becomes heat, 90% becomes mechanical work) *and* have a 0.8 power factor (meaning due to inductance it draws more current than a purely resistive 4/5 of the apparent power is real). Both affect the electrical system: efficiency affects how much power is wasted as heat, while power factor affects how much extra current is drawn. The exam could have separate questions touching on each.

- *Capacitor sizing:* If you do need to calculate a capacitor for correction, rearrange $Q_C = V^2\omega C$ to $C = Q_C/(V^2\omega)$. Make sure to use line-to-neutral voltage for a delta/wye three-phase situation if you go per-phase. Often easier: compute the VARs needed (Q_C) and then the question might not even need the exact C value, depending on how it's phrased (it could ask "how many VARs of

capacitance are required," to which you answer in VAR, not Farads).

Variations and Related Forms:

- **Complex power formula:** The relationship $S = P + jQ = VI^*$ is a compact representation (where I^* is the complex conjugate of current phasor). While you don't need to explicitly use complex conjugates on the FE, it's good to remember that you can calculate P and Q by $P = \mathrm{Re}(VI^*)$ and $Q = \mathrm{Im}(VI^*)$. In practice, $P = VI\cos\phi$ and $Q = VI\sin\phi$ are easier since V, I, ϕ are readily interpreted.

- **Power factor from impedance:** If you determine a circuit's total impedance $Z_{\mathrm{eq}} = R_{\mathrm{eq}} + jX_{\mathrm{eq}}$, the power factor for a source driving that impedance is $\cos\phi = \frac{R_{\mathrm{eq}}}{|Z_{\mathrm{eq}}|}$. Essentially, $\phi = \arctan\left(X_{\mathrm{eq}}/R_{\mathrm{eq}}\right)$ is the same phase angle between total voltage and current. So you could find pf by looking at the impedance triangle as well (R vs X). This is often a quick way: e.g., a load with impedance $40 + j30\ \Omega$ has pf $= 40/\sqrt{40^2 + 30^2} = 0.8$ lagging (since +j30 means inductive).

- **Resonant and unity pf:** In RLC circuits at resonance ($\omega = 1/\sqrt{LC}$), the reactive parts cancel and the circuit's power factor becomes 1 (because effectively $X_{\mathrm{eq}} = 0$, purely resistive). At resonance, an AC circuit draws the minimum current for a given real power P (since no reactive current). Sometimes an exam question could indirectly test this: "At what frequency will the power factor be unity?" – the answer is the resonant frequency where inductive and capacitive reactances cancel.

- **Typical values:** Household appliances and incandescent lights are near pf = 1 (resistive). An unloaded motor might be around 0.6 lagging, a fully loaded motor might improve to 0.85–0.90 lagging. Industrial facilities add capacitor banks to bring their overall pf up to ~0.95 to avoid utility charges. On the leading side, you typically won't see leading power factor unless you have capacitor banks or lightly loaded synchronous machines – it's less common to encounter but theoretically similar in magnitude effect. On the exam, expect most loads to be lagging pf unless they explicitly mention capacitors.

- **Voltage regulation:** While not explicitly asked in the subtopic, note that power factor affects voltage drop in transmission lines (for the same P, a low pf means higher current, hence more IR drop in the line). So if you see a question about voltage drop or regulation, improving pf can be an answer to mitigate line losses and drops. This ties into why correction is done – not just to reduce apparent power, but also to reduce strain on the whole system.

Special Notes: Modern calculators can help with power factor questions too. For example, you could compute an angle φ by using the arccos (inverse cosine) of a given pf. Make sure the calculator is in degree mode if you want φ in degrees (usually easier to interpret). If solving for capacitance in pf correction, remember to use the angular frequency ω. Also, be aware that the exam may allow a certain level of simplification: if the question is conceptual (e.g., "how does adding a capacitor affect power factor?"), your explanation can be qualitative: *"It reduces the magnitude of reactive power, thus increasing pf (bringing it closer to 1)."* Only break into calculations if it's a quantitative question. And finally, double-check any answers that ask for "leading or lagging" – make sure you include that designation if required ("0.95 lagging" not just "0.95"). It's about direction of phase, which is part of a complete answer in power factor problems.

Topic 04 - Motors and Generators

Topic Introduction – Why It Matters: Motors and generators are devices that convert energy between mechanical and electrical forms. On the FE Mechanical Exam, you'll encounter questions that tap into the core principles behind these machines, without diving into heavy design details. Expect to use fundamental laws of electromagnetics – like Faraday's law of induction (for generators) and the Lorentz force (for motors) – as well as key machine concepts like synchronous speed and slip (for AC motors). A typical exam problem might ask you to compute an induced voltage given a changing magnetic flux, determine a motor's speed given the supply frequency and number of poles, or find the slip of an induction motor under load. By mastering the basics in this chapter, you'll be equipped to quickly recognize **Motors and Generators** problems on exam day and apply the right formula or concept confidently. Remember, these principles bridge mechanical and electrical engineering – a **motor** uses electrical power to create motion (mechanical work), while a **generator** uses motion to create electrical power. Both rely on the same two flip-side phenomena of electromagnetism outlined below.

K05.T04.S01 – Principles of Electromechanical Energy Conversion

Principle Introduction:

- Faraday's Law of Induction: A changing magnetic flux through a circuit induces an electromotive force (voltage) in that circuit. In practical terms, moving a magnet near a coil or changing the current in a nearby coil will induce a voltage – this is the fundamental principle behind generators and transformers.

- Lorentz Force (Motor Effect): A current-carrying conductor or moving electric charge in a magnetic field experiences a force. This is the principle behind motors – a wire carrying current in a magnetic field is pushed perpendicular to both the current and field directions, converting electrical energy into mechanical force or torque.

- Two Sides of One Coin: Faraday's law and the Lorentz force are complementary. Faraday's law (generator action) converts motion/flux change into electricity, while Lorentz force (motor action) converts electricity into motion. Together, they form the basis of electromechanical energy conversion – any electric motor or generator is using one or both of these phenomena. Think of it this way: if you spin a coil in a magnetic field, Faraday's law says you get a voltage (generator); if you run current through a coil in a magnetic field, Lorentz says you get a force/torque (motor).

- Exam relevance: You may be asked to calculate induced voltage from a changing flux (using Faraday's law) or to find the force on a wire in a magnetic field (using the Lorentz force). These fundamentals can also appear indirectly – for example, understanding that an induction motor needs a changing flux (from slip) to induce currents in the rotor (Faraday's law) which then produce torque (Lorentz force). Keeping these core ideas straight will guide you in solving a range of motors/generators problems.

Exam Handbook Search Cues (Not affiliated with or endorsed by NCEES): *Faraday's law; induced voltage; magnetic flux; Lorentz force; force on conductor;* $\mathbf{F} = I\mathbf{L} \times \mathbf{B}$. (Use these terms to quickly find reference formulas in the exam handbook – they're the keywords provided in the official reference.)

Equation Passport – Faraday's Law of Induction: *Calculates the induced voltage in a coil due to changing magnetic flux (generator principle).*

- **Formula:** $v = -N \frac{d\Phi}{dt}$
- **Variables and Units:**
- v – Induced voltage (volts, V)
- N – Number of turns in the coil (dimensionless)
- Φ – Magnetic flux through *one* turn (webers, Wb) – flux is the product of magnetic flux density B and the perpendicular area of the loop (1 Wb = 1 T·m²)
- $\frac{d\Phi}{dt}$ – Time rate of change of the flux (Wb/s)

Assumptions and Scope:

- The coil's turns are linked by the same average flux Φ (e.g. a tightly wound uniform coil). N multiplies the effect of a single turn – more turns means a larger induced voltage for the same flux change.
- The negative sign (Lenz's law) indicates the polarity of the induced voltage opposes the change in flux. For exam calculations, you often take the magnitude $|v| = N \frac{d\Phi}{dt}$ and use the sign separately to reason about direction (such as current direction opposing the change).
- This law assumes classical electromagnetism (no quantum or relativistic effects) – perfectly fine for all macroscopic scenarios like motors, generators, transformers on the FE exam. It's essentially one of Maxwell's equations in circuit form.
- **What's in/out:** Faraday's law covers any situation with changing magnetic flux through a loop: a moving magnet, a changing current in a nearby coil, or a rotating coil in a field. It does not directly give you force or torque – for that, you use Lorentz force.
- **Limit Checks (Sanity Test):** If the magnetic flux is not changing ($d\Phi/dt = 0$), the induced voltage $v = 0$. (No change in flux → no induced EMF, as expected.) If you double the number of turns N, the induced voltage doubles – a coil with more loops catches more flux change. If flux changes very rapidly, $d\Phi/dt$ is large, and thus v is large (which aligns with the idea that a quick swipe of a magnet past a coil produces a bigger jolt than a slow move). As a consistency check on units: 1 volt is 1 weber per second.
- **Use vs. Sibling Equations:** Use Faraday's law when you need the induced voltage from a changing magnetic situation. This is the go-to equation for generator action or transformer induction on the exam. *Do not confuse it with the formula for an inductor's voltage* $v_L = L\, di/dt$, *which is actually a result of Faraday's law for self-induced flux in an inductor – in the exam context, they'll usually either directly give you* $v = -N\, d\Phi/dt$ *or a simplified scenario.* Also, if you have a straight conductor of length ℓ moving at velocity u through a uniform magnetic field B (perpendicular to both B and the motion), Faraday's law predicts an induced voltage $E =$

$B\,\ell\,u$. This is a special case often used for a rod moving through a magnetic field – essentially the same physics in a different guise (sometimes called motional EMF).

Common Exam Traps:

- **Dropping the minus sign:** Many times, you'll be asked for the magnitude of the induced voltage, so you might ignore the "–" in practice. But remember its meaning: if the problem discusses direction or polarity (say, which end of a coil is positive), the negative sign is crucial (it tells you the induced effect opposes the change in flux).
- **Mixing up flux vs. field:** The symbol Φ (phi) is magnetic *flux* (in webers), whereas B is magnetic *flux density* (in teslas). Make sure you have the total flux through the coil. For example, if a problem gives a magnetic field strength and an area, you may need to compute $\Phi = B\,A\cos\theta$ (with θ the angle between the field and the area normal). If they directly give "flux in webers," you're ready to go.
- **Unit consistency:** Ensure $d\Phi/dt$ is in Wb/s. Sometimes flux might be given as $\Phi(t) =$ something like $0.002\sin(\omega t)$ Wb; differentiating introduces factors of ω. Be comfortable taking a derivative if needed and plugging in numbers. Also, watch prefixes: a flux change of 5 mWb/s is 5×10^{-3}Wb/s, which induces 5 mV in one turn (or 50 mV in 10 turns). Small misreads of "milli" can lead to answers off by factors of 1000.

Equation Passport – Lorentz Force (Magnetic Force on Conductor): *Gives the force exerted on a moving charge or current in a magnetic field (motor principle).*

- **Formula (vector form): $\mathbf{F} = I\,\mathbf{L} \times \mathbf{B}$**
  (For a straight current-carrying wire of length L in a uniform magnetic field. The direction of **F** *is perpendicular to both the current direction (***L** *direction) and the field* **B***, following the right-hand rule.)*
- **Magnitude form:** $F = I\,L\,B\sin\theta$
  (where θ is the angle between the wire (current direction) and the magnetic field. Maximum force when $\theta = 90°$ (wire $\perp$ field); zero force when the wire runs parallel to the field.)

Variables and Units:

- **F** – Force vector on the conductor (newtons, N). Its direction is given by the cross product $\mathbf{L} \times \mathbf{B}$: point your right-hand **index finger** along the current (direction of conventional current), your **middle finger** along **B**; your **thumb** then points in the direction of **F**.
- I – Electric current through the conductor (amperes, A). More current = proportionally stronger force.
- **L** – Length **vector** of the conductor segment in the field (meters, m). The direction of **L** is along the direction of current flow, and the magnitude L is the length of wire within the magnetic field. (E.g. if 0.2 m of the wire is inside the uniform field region, $L = 0.2$ m.)
- **B** – Magnetic flux density (magnetic field vector, tesla, T). 1 tesla = 1 N/(A·m). A stronger B field or a longer wire or higher current all increase the force linearly.
- *(For completeness: the Lorentz force law in general is* $\mathbf{F} = q\,(\mathbf{E} + \mathbf{v} \times \mathbf{B})$ *for a charge q. The* $I\,\mathbf{L} \times \mathbf{B}$ *form given is essentially the magnetic part, considering many charges q moving in the wire. We neglect any electric field* **E** *here because we're focusing on the magnetic force on a current.)*

Assumptions and Scope:

- The formula assumes a straight conductor in a uniform magnetic field. If the wire is curved or the field is non-uniform, you'd integrate small segments $d\mathbf{F} = I\,d\mathbf{L} \times \mathbf{B}$. But for FE exam purposes, problems will usually give a simple geometry or an already integrated form (like using the length of the wire in the field, as above).
- Direction: We assume conventional current direction for I (from positive to negative terminal in the external circuit). The right-hand rule (for positively charged current carriers) gives the force direction. If current is reversed, force reverses. If the magnetic field reverses, force reverses. No force if current is parallel to the field (since $\sin 0° = 0$).
- Scope: This is the principle behind motor action – a current loop in a magnetic field experiences a torque because opposite sides of the loop get forces in opposite directions (one up, one down, causing rotation). The equation here gives the force on one segment; in a typical motor, multiple conductors on a rotor and the geometry cause a net torque which is what spins the motor shaft. On the exam, you likely won't be calculating motor torques directly from first principles, but understanding $F = ILB$ explains why a motor produces force and how factors like current or field strength will affect the force/torque.
- This formula is purely magnetic. If a problem had charges moving through an electric field as well, you'd separately consider electric forces $F_E = qE$, but that's a different topic (electrostatics). In motors/generators context, usually either the magnetic effect is in focus or the electric force is zero (e.g. charges moving in a wire that's electrically neutral overall).
- **Limit Checks:** If $I = 0$ (no current), then $F = 0$ – no surprise: without current, a magnetic field won't push a stationary wire (there's no charged motion for the field to act on). If $B = 0$, then $F = 0$ – no magnetic field, no force on the current (which is why we need magnets or electromagnets in motors). If the wire is oriented parallel to the field ($\theta = 0$ or $180°$), $F = 0$ as noted – the magnetic force is perpendicular to the field, so it can't pull or push along the field lines, only sideways. The force is maximized at $\theta = 90°$ (wire perpendicular to field). Units check: 1 A·m in a 1 T field yields 1 N of force (since 1 T = 1 N/(A·m)), so the units are consistent.
- **Use vs. Sibling Equations:** Use this magnetic force equation whenever you need the force on a current in a magnetic field. It's directly applicable to straight wires, and by extension to forces on moving charges (where you'd use $F = qvB$ for a single charge moving at velocity v perpendicular to B). *Do not confuse this with Coulomb's law of electrostatics (force between charges) or the force due to an electric field on a charge ($F = qE$).* The Lorentz force here is purely the magnetic component and requires motion or current. Also, distinguish it from torque formulas – sometimes in rotating machines you'll see torque $T = k\,\Phi\,I$ (in DC motors) or similar; those are derived from the Lorentz force on many charges in a

specific configuration. If needed, you can always go back to $F = ILB$ for a single wire and derive torque by $T = F \times$ radius for a loop.

Common Exam Traps:

- **Forgetting the direction (vector nature):** The exam might ask for the *direction* of force or motion (e.g. "which way will the conductor move?"). Remember the right-hand rule: Current I (thumb) crossed into B (index-to-middle) gives force F (palm/thumb). A quick way: use your right-hand palm rule – align your palm so that the field B goes **into** your palm and your fingers point in the direction of current, then your thumb points in the direction of the force on the conductor. If you use your left hand by mistake or mix up the orientation, you'll get the opposite direction – a costly error. Practice a couple of simple scenarios to cement this.
- **Mixing up angles:** The $\sin\theta$ uses the angle between the current direction (wire) and the magnetic field. If a problem instead gives the angle between the wire and some reference or between the field and some surface, make sure you interpret θ correctly. For instance, if a wire is 30° from horizontal and B is horizontal, the angle between wire and B is 30°. If they said the field is 60° to the wire, then you'd use 60° in $\sin\theta$. In short, clarify what the angle is between – it must be between the *directions of current and field*.
- **Numerical unit mistakes:** Current in A, length in m, B in T → force in N. Sometimes length might be given in centimeters or field in millitesla. Convert them to standard units. Also, ensure you're using the correct length that is within the field region – if a 10 cm wire has only 8 cm within the uniform field, use 0.08 m.
- **Forgetting that force is on *current***: The formula $F = ILB$ presumes a current-carrying conductor. If the exam scenario is a *moving non-conducting object with charge*, use $F = qvB$ instead (with q in coulombs, v in m/s). Usually FE Mechanical won't go deep into charged particle physics, but it could show up conceptually or as a quick check that you know the general form (which is basically the same principle).

Magnetic Flux vs. Flux Density: Magnetic *flux density* B (T) is a field intensity (like how concentrated the field lines are), whereas magnetic *flux* Φ (Wb) is the total field passing through an area. Think of B like rainfall rate and Φ as the total rain captured by a bucket of a certain size – increase the rain rate B or the bucket area A and you get more total rain (flux $\Phi = B \times A$).
Units – Weber per second: One weber per second of changing flux induces one volt. For example, if the flux through a 50-turn coil increases at 0.02 Wb/s, the induced voltage magnitude is $N \times d\Phi/dt = 50 \times 0.02 = 1$ V.

No Motion, No Force: A useful mental check is that magnetism only acts on moving charges. If charges are not moving relative to the field, the magnetic part of Lorentz force is zero – which is why a stationary charged particle feels no magnetic force, and a stationary wire (no current) in a magnetic field doesn't jump. (It might feel a tug if the magnetic field is non-uniform, but that's a different effect beyond our scope.)

K05.T04.S02 – AC Machines: Synchronous Speed & Slip

Principle Introduction:

- Synchronous Speed (of AC machines): This is the speed at which the magnetic field in an AC machine's stator rotates. It depends on the supply frequency and the number of poles in the machine. *Synchronous machines (like synchronous motors and AC generators) operate locked at this speed.* For example, a 2-pole motor on 60 Hz power has a synchronous speed of 3600 rpm. Synchronous speed matters because it's the theoretical no-load speed of an induction motor and the exact operating speed of a synchronous motor.

- Induction Motor Operation and Slip: Induction motors (also called asynchronous motors) always run a bit *slower* than the synchronous speed. This difference in speed is intentional and necessary – it's called **slip**. Slip is the fraction (or percentage) by which the rotor lags behind the synchronous speed of the stator's magnetic field. Why is this needed? Because only if the rotor is slipping behind the rotating field is there a changing flux linking the rotor (per Faraday's law) to induce currents in the rotor bars. Those induced currents then interact with the stator's magnetic field (via Lorentz force) to produce torque. No slip = no induced current = no torque.

- Key Relationship: The greater the load on an induction motor, the more torque it needs to produce, and the more it will slow down (increasing slip) to induce the necessary current. At no load, an induction motor's rotor will come very close to synchronous speed (small slip, just enough to overcome losses). At full load, slip might be a few percent (e.g. rotor might turn at 1750 rpm while synchronous is 1800 rpm for a 4-pole, 60 Hz motor – that's about 2.8% slip). If the load is too high, the slip increases further; beyond a certain point the motor can't produce more torque and will stall (100% slip, rotor stopped).

- Exam Relevance: You could be asked to compute synchronous speed given frequency and poles, or determine slip given an induction motor's rated speed vs synchronous speed. These are straightforward calculations if you know the formulas. It's also useful to understand conceptually what slip represents (they might present a conceptual question like "why can't an induction motor reach synchronous speed?" or something about relative speed inducing current). Synchronous motors might be mentioned – note that they have zero slip in steady state (rotor locks in step with the rotating field) and require an external excitation to run at exactly synchronous speed. DC motors, while a category of "machines", don't have a "synchronous speed" because they aren't tied to AC frequency; instead their speed is controlled by voltage and load, so they're not part of this particular formula set.

Exam Handbook Search Cues (Not affiliated with or endorsed by NCEES): *synchronous speed;* $n_s = 120f/p$*; induction motor slip; slip* $(n_s - n)/n_s$*; motor poles.* (These are the terms you'd use to find these formulas in the exam reference – for instance, searching "synchronous speed" or "slip" will get you the relevant equations quickly.)

Equation Passport – Synchronous Speed of AC Machines: *Relates the electrical supply frequency and number of poles to the speed of the rotating magnetic field (in RPM). This is the no-load speed of a synchronous motor or the theoretical speed an induction motor's field rotates.*

- **Formula:** $n_s = \frac{120f}{p}$

Variables and Units:

- n_s – Synchronous speed (revolutions per minute, RPM). This is how many mechanical rotations per minute the magnetic field makes.
- f – AC line frequency (hertz, Hz = cycles per second). In North America $f = 60$ Hz; in many other regions $f = 50$ Hz. The higher the frequency, the faster the field spins.
- p – Number of poles of the machine (unitless count of magnetic poles). This is an inherent design property of the motor/generator's winding configuration. Poles come in pairs of north and south – a "2-pole" machine has one north and one south pole, a "4-pole" has two north and two south, etc. More poles means the field completes fewer mechanical revolutions per electrical cycle, so the synchronous speed is lower. (Be careful: p is the total number of poles, not the number of pole pairs. The formula already accounts for the 2 poles per pair with the factor 120.)

Assumptions and Scope:

- The machine's stator is fed with a balanced AC (usually three-phase for motors) at frequency f. The magnetic field in the machine will rotate at this synchronous speed n_s. The rotor of a synchronous motor, if properly excited and started, locks onto this rotating field and spins at exactly n_s. In an induction motor, the rotor will always be a bit slower (providing the slip). In an AC generator (alternator), the rotor is typically spun at n_s to produce electricity at the desired frequency f.
- Units: The formula yields rpm directly when f is in Hz and p is an integer. The constant 120 is 2×60 (since 60 s $= 1$ min and the factor 2 accounts for the north-south pole pair per cycle). If you need angular velocity in rad/s for something, you can convert: $\omega_s = \frac{2\pi n_s}{60} = \frac{4\pi f}{p}$ rad/s.
- Scope: This formula assumes a standard induction or synchronous machine where the relationship between electrical cycles and mechanical rotation is determined by pole count. It doesn't apply to DC motors (no alternating field) or universal motors, etc., which aren't tied to a fixed frequency. On the FE exam, stick to using this for AC motor/generator problems.

Typical Values / Examples:

- For a **60 Hz** system:
  - $p = 2$ (one pair of poles) $\rightarrow n_s = 120(60)/2 = 3600$ rpm.
  - $p = 4 \rightarrow n_s = 120(60)/4 = 1800$ rpm.
  - $p = 6 \rightarrow n_s = 120(60)/6 = 1200$ rpm.
  - $p = 8 \rightarrow n_s = 120(60)/8 = 900$ rpm. These are common synchronous speeds for industrial motors (3600, 1800, 1200, 900… for 60 Hz). If you see a motor nameplate stating "1750 rpm" for example, you can guess it's a 4-pole motor at 60 Hz with a slight slip (1800 sync minus 50 rpm slip).
- For **50 Hz**:
  - $p = 2 \rightarrow 3000$ rpm, $p = 4 \rightarrow 1500$ rpm, $p = 6 \rightarrow 1000$ rpm, etc. (50 Hz is less common in U.S. exam context but could appear in a general question; just use the formula.)
- **Limit Checks:** If you set $p = 0$ (meaningless physically), the formula blows up – which makes sense, you can't have zero poles. If p is very large, n_s becomes very low; for example a 20-pole motor at 60 Hz has $n_s = 360$ rpm. This shows the trade-off: more poles yield lower speed but higher torque for a given frequency (common in large slow-speed motors or wind turbine alternators, etc.). If $f = 0$ (DC or turned off supply), $n_s = 0$ – the field is not rotating at all. The formula is linear in f: double the frequency, double the synchronous speed. Also note, p is usually even (poles in pairs), and the formula inherently assumes that by using 120.
- **Use vs. Confusion Points:** Use this equation whenever you need the ideal motor speed from frequency and poles. It's unique – there isn't really another common formula it might be mistaken for, except perhaps the relation $\omega = 2\pi f$ for electrical angular frequency. But that one doesn't include p. Just remember: **120 f/p for rpm** (it's easy if you remember 60 Hz and 2 poles gives 3600 rpm, a well-known number). *Don't apply this to DC or universal motors; they aren't constrained by f and p in this way.* And if faced with a gear or pulley system, that's a different scenario (mechanical speed ratios) – not to be mixed with synchronous speed of an AC field.

Common Exam Traps:

- **Mixing up p (pole count) vs. number of pole pairs:** Some textbooks use p to mean pole pairs. In our formula here, p is total poles. If a problem statement says "a four-pole induction motor…", plug $p = 4$ into the formula. Don't halve it. The 120 factor has taken care of the 2 poles per pair. (If you were to mistakenly use pole pairs, e.g. 2 for a four-pole, then $n_s = 120 * 60/2 = 3600rpm$, which would be wrong for a four-pole 60 Hz motor – it should be 1800 rpm.)
- **Unit awareness (RPM vs rad/s):** The answer might be needed in rpm or in other units. The formula directly gives rpm. If a problem expects an answer in, say, revolutions per second or rad/s, do the conversion. For instance, 1800 rpm is 30 rps (since 1800/60) or about 188.5 rad/s (since $2\pi \times 30$). If you mix up and treat the formula output as rad/s inadvertently, you'll be off by a factor of $2\pi/60$.
- **Poles vs. speed relationship:** Sometimes exam questions might present multiple-choice answers that test if you know inverse relationships. E.g., "What happens to synchronous speed if the number of poles is doubled?" The correct reasoning: doubling p halves n_s (for same f). Just be ready for conceptual questions like "a 60 Hz, 8-pole motor runs at ~900 rpm synchronously; what speed would a 4-pole motor run at on 60 Hz?" (Answer: ~1800 rpm). That's just using the formula conceptually.

Equation Passport – Induction Motor Slip: *Defines slip, the fraction (or percentage) difference between the synchronous speed of the magnetic field and the actual rotor speed. This measures how*

much the induction motor "slips" behind the synchronous speed to produce torque.

- **Formula:** $s = \frac{n_s - n}{n_s}$

Variables and Units:

- s – Slip (unitless fraction, often expressed as a percentage). $s = 0.05$ means a 5% slip. If needed, multiply by 100% to get percentage slip.
- n_s – Synchronous speed (rpm) of the stator's rotating field (from the formula above). Think of this as the "reference" speed the rotor tries to reach but never quite does (in motor mode).
- n – Rotor speed (rpm). This is the actual mechanical rotation rate of the rotor (and the shaft). It will be a bit lower than n_s when the motor is driving a load.

Assumptions and Scope:

- This definition assumes we're dealing with an induction machine in **motor** operation (the rotor is being dragged around by a rotating magnetic field and lags behind it). In generator action (an induction machine driven above synchronous speed), the same formula can yield a negative slip, but that scenario is less common and usually not tested on FE (it's more power engineering). So generally $0 \leq s < 1$ for an induction motor under load.
- Slip is dimensionless. It can also be expressed as a percentage: $\%s = 100\% \times \frac{n_s - n}{n_s}$. Small slip means the rotor is very close to synchronous speed (lightly loaded motor). Larger slip means the rotor is significantly slower than the field (heavily loaded, drawing more current to produce more torque). In normal operation, slip might be anywhere from a fraction of a percent (for a tiny load or an over-engineered motor) to a few percent (for a motor near its rated load). Design-wise, motors are built such that at full rated load, slip is maybe 1-5%.
- If $n = 0$ (motor stalled or starting from rest), then $s = 1$ or 100%. This is the maximum slip in motor mode. At start-up, induction motors have 100% slip – that's why they initially draw a large current (to start generating torque from zero speed).
- If $n = n_s$, then $s = 0$. That's the condition of a synchronous motor (or an induction motor at no load, in the theoretical limit). But an induction motor can never actually reach exactly n_s under load because then there'd be no induction to keep it turning (it needs a little slip to keep pulling).
- **Scope:** Slip is specifically a concept for induction (asynchronous) machines. **Synchronous machines** by definition run at $s = 0$ (or they fall out of sync and stop working properly). **DC motors** don't have a "synchronous speed" per se, so slip isn't used there. For exam purposes, slip is tied to induction motor questions.

Variations and Related Forms:

- Sometimes you might see slip defined in terms of frequency: The slip is also the ratio of the difference between synchronous electrical frequency and the rotor's electrical frequency. For instance, the frequency of currents induced in the rotor (the slip frequency) is $f_{\text{rotor}} = s \times f_{\text{line}}$. If the motor is almost at sync, slip is small, and rotor current frequency is low. If the rotor is stalled (s=1), rotor current is at line frequency. This relation is good to know conceptually, though calculating rotor frequency is rarely needed in a mechanical FE context.
- Another related concept: **Rotor Slip Speed** – the difference in speed (in rpm) between the synchronous field and rotor, i.e. $n_s - n$. Sometimes a problem might directly or indirectly give you that (e.g. "the rotor lags 90 rpm behind sync"). But usually, using the fractional slip s is more convenient.
- If slip is given as a percentage in a problem, remember to convert to a decimal in calculations. E.g. "4% slip" means $s = 0.04$.

Limit Checks:

- At **no load (ideal)**, $n \to n_s$ and so $s \to 0$. That means virtually no slip – the motor is almost synchronous because it doesn't need torque (just enough to overcome tiny losses). Practically, an unloaded induction motor might run at 99% of n_s (s = 0.01).
- At **full load**, s is a small positive number like 0.02–0.05 (2–5%) in many designs. The rotor speed drops just enough to induce the needed current to drive the load.
- At **stall (locked rotor)**, $n = 0$ so $s = 1$ (100% slip). This is the extreme case, corresponding to maximum possible current draw (locked-rotor current) and zero mechanical output (all input energy turns into heat).
- In normal **motor** operation, slip satisfies $0 \leq s \leq 1$(with $s = 1$only at locked-rotor stall). Values beyond this indicate abnormal or generator-mode behavior (e.g., forcing the rotor backward relative to the rotating field), which the FE exam typically doesn't explore. Also slip can't be negative for a motor running below sync. Negative slip would mean $n > n_s$, i.e. rotor is going faster than the magnetic field – that's induction generator territory: if you drive an induction motor above sync speed, it will start generating power back into the grid with a negative slip value. That's beyond what most FE questions cover, but just know slip sign indicates motor vs generator action for induction machines.
- **Use vs. Confusion Points:** Use this formula to find the slip given speeds, or to find rotor speed given slip, etc. It's straightforward algebra once you know it. One possible confusion: sometimes people might wonder if they should use this for **synchronous motors** – *no!* Synchronous motors have no slip in steady operation (s = 0). If a synchronous motor falls behind (i.e. any slip develops), it will rapidly lose sync unless brought back – in practice they have damper windings that act like an induction motor briefly to pull it back, but that's extra detail. So, do not apply the slip formula to synchronous machines except to say s=0 for them. Also, do not confuse "slip" in motors with other uses of the word (e.g. "gear slip" or "belt slip" in mechanics – that's a different concept of mechanical slipping, unrelated to the electromagnetic slip here).

Common Exam Traps:

- **Using the wrong speed for n_s or n:** Make sure you identify the synchronous speed correctly (usually by computing $120f/p$). For example, a question might state "A 60 Hz, six-pole induction motor runs at 1160 rpm under load. What is the slip?" First compute $n_s = 120 * 60/6 = 1200$ rpm. Then $s = (1200 - 1160)/1200 = 0.0333\ldots \approx 3.33\%$. A mistake would be to plug the wrong n_s (say, use 3600 or 1800 by confusion). Always tie n_s to pole count and frequency given.
- **Fraction vs Percent:** If the question asks for percent slip, give the answer in percentage form. If your calculation gave 0.0333, that's 3.33%. Conversely, if a problem statement says "slip = 5%," use 0.05 in any further calculations unless explicitly working in percent form. It's easy to be off by a factor of 100 if you forget to convert.
- **Sign confusion:** In normal motor problems, $n_s > n$ so slip is positive. If you accidentally subtract the other way ($n - n_s\ over\ n_s$), you'll get a negative number. Use the definition exactly as given (sync minus rotor, over sync) to avoid a sign error. The positive slip indicates how far *behind* the rotor is.
- **Rounding/approximation:** Sometimes you might get a slip value like 0.0277 (which is 2.77%). If the answers are in percentages, they might round to 2.8% or 3%. Don't be thrown off by slight differences due to rounding – slip in practice is often quoted to whole numbers like "~3%". So understand the range: if your calculation and the nearest answer differ by a tiny bit, it's likely just rounding.

Explanation & Analysis (Step-by-Step): Let's tie these concepts together with a practical mindset. **Synchronous speed** $n_s = 120f/p$ gives the baseline speed of the rotating magnetic field in an AC motor. If you're designing a motor or generator, you pick the number of poles to get the desired speed for a given frequency. For instance, want ~1800 rpm at 60 Hz? Use 4 poles. Want ~3600 rpm? Use 2 poles. This is why many 60 Hz motor speeds cluster around those values (minus a bit for slip). On exam problems, once you compute n_s, you have a reference for that machine's speed characteristics.

Now, **induction motors**: their quirk (and genius) is that the rotor is not physically connected to the AC source – instead it's induced. How? The stator's rotating field sweeps past the rotor conductors. If the rotor were at synchronous speed, the field would not be moving relative to the rotor – no changing flux -> no induced current -> no torque. So, the rotor must lag slightly. That lag is quantified by **slip** s. A small slip means the rotor is only slightly slower, so the relative motion between field and rotor is small – which induces just enough current to overcome light loads. A larger slip means the rotor is notably slower than the field, so the relative motion is bigger – inducing more current, hence more torque to handle heavier loads. This self-regulating behavior is why induction motors are so popular: they draw more current and produce more torque as needed when load increases, up to their limit (the point of maximum torque, often called breakdown torque, beyond which the motor stalls if load increases further).

For a quick **analysis example**, imagine a **4-pole, 60 Hz induction motor**: $n_s = 1800$ rpm. If it's driving a moderate load and turning at 1720 rpm, slip $s = (1800 - 1720)/1800 = 0.0444$ (4.44%). That slip produces enough induced current to create the torque for that load. If the load increases, the motor might slow to 1680 rpm (slip 6.7%) to generate more torque. If load really increases beyond capacity, the motor might not be able to go any slower without stalling – the slip at maximum torque is maybe around 10-15% depending on design, beyond which it stalls (100% slip, 0 rpm). Conversely, if the load is very light, the motor might speed up to 1790 rpm (slip 0.5%) because it doesn't need much torque (just overcoming friction and windage). In exam questions, you'll typically get the numbers to plug in rather than having to intuit all this, but knowing the normal ranges (a few percent slip) can help you catch if an answer seems unreasonable (like if you calculated a slip of 50% for a normal running motor, something's off unless it's a special scenario like a two-speed motor at an in-between state or an error).

Synchronous motors differ in that their rotors are magnetized (often by DC excitation) and lock onto the rotating stator field, spinning exactly at n_s. They don't rely on induced current in the rotor for steady torque (though they may have a startup mechanism). For the exam, just recall: synchronous motor/generator = no slip in steady state, induction motor = some slip.

In summary, for motors and generators: use Faraday's law when thinking about how voltages are induced (generator mode, transformer action, even the rotor currents in induction motors come from Faraday's law!), and use Lorentz force when thinking about how forces or torques are produced (motor mode, forces on conductors). Then apply the machine-specific formulas like $n_s = 120f/p$ and slip for the AC motor scenarios. With these tools, you can dissect most FE exam problems in this area: identify what is being asked (induced voltage? use Faraday; force or torque? use Lorentz; motor speed or slip? use the machine formulas), plug in the values, and double-check units and reasonableness. You'll be solving motor-generator questions like a pro, converting between electrical and mechanical quantities with confidence – a skill that not only scores points on the FE, but is fundamental to understanding how the devices powering our world operate.

Radians per Second: Converting rpm to rad/s is done by $\omega = 2\pi \times (\text{rpm})/60$. Using the $120f/p$ formula: n_s rpm becomes $\omega_s = 2\pi n_s/60 = 2\pi(120f/p)/60 = 4\pi f/p$ (in rad/s). For example, 1800 rpm is 188.5 rad/s. This might be useful if a question involves angular velocities or wants an answer in SI units. But if not specifically needed, giving speed in rpm is perfectly fine and often more intuitive for motors.

DON'T MOVE ON YET!

Work Through Some Solid Practice Problems
while the Material of this Knowledge Is Still Fresh
THIS IS HOW THE CONCEPTS LOCK IN.

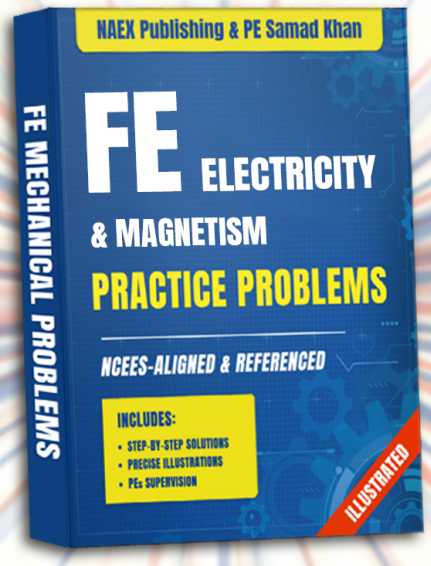

CLICK HERE TO PRACTICE

You'll be taken to our Discord Server, where the problems are located.

KNOWLEDGE 06

STATICS

- NAEX Publishing -

"This publication is not affiliated with or endorsed by NCEES".

.

Topic 01 - Resultants of Force Systems

Topic Overview: In **Resultants of Force Systems**, we learn how to replace multiple forces acting on a body with simpler equivalent forms. This includes finding a **single resultant force** that has the same effect as a set of forces, determining the **moment (torque) caused by forces** about a point and simplifying force-and-couple combinations, and replacing **distributed loads with concentrated resultants**. Finally, we apply **equilibrium conditions** (net force zero, net moment zero) to ensure a system is balanced. Mastering this topic is crucial for the FE Mechanical Exam: it underpins typical statics questions like finding support reactions on a beam (by reducing loads to resultants), calculating the net effect of multiple forces on a bracket, or checking if a structure is in equilibrium. The key is recognizing how to **simplify a complex force system** into a few summary values (total force and total moment) that are much easier to work with on exam day.

K06.T01.S01 – Vector Addition of Forces in Two Dimensions (Resultant Force)

Principle Introduction: *When multiple forces act on a body in a plane, you can combine them into one single resultant force vector.* The resultant is found by **vector addition** of all individual forces, which means adding up their components along each axis. Key points and intuition:

- **Forces are vectors:** Each force has magnitude and direction. You add forces head-to-tail (graphically) or component-wise (analytically) just like displacements or other vectors.
- **Component addition:** Any force can be broken into orthogonal components (usually x and y). Sum all x-components together and all y-components together – these sums form the components of the resultant.
- **Single equivalent force:** The combined effect of several forces can be represented by one resultant force $\mathbf{F}_{res}$. This resultant produces the same acceleration on a free body as all the original forces acting together (by Newton's second law).
- **Magnitude and direction:** Compute the resultant's magnitude via the Pythagorean combination of total components, and find its direction (angle) via a tangent ratio. This yields the **size** of the net force and where it points.
- **Planar (2D) focus:** In statics, most problems confine forces to a plane (e.g. on a flat diagram). We assume forces lie in a common plane so that we only worry about two components (no out-of-plane z component here).

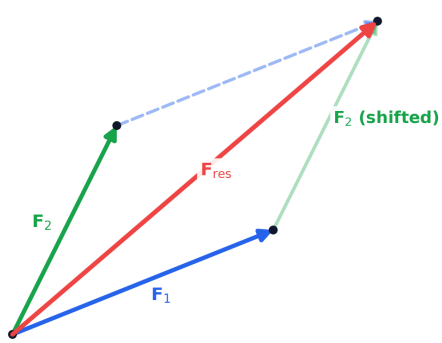

*Illustration: Using the parallelogram law to find the resultant of two forces. Two example forces $\boldsymbol{F}_1$ and $\boldsymbol{F}_2$ are added tip-to-tail. The single **resultant** $\boldsymbol{F}_{res}$ is the diagonal of the parallelogram formed. Component-wise, $\boldsymbol{F}_{res}$ has an x-component equal to the sum of the two forces' x-components, and similarly for y. This graphical construction reflects the same calculation you would do by summing components algebraically.*

Exam Handbook Search Cues (Not affiliated with or endorsed by NCEES): *resultant force, vector sum, components, two-dimensional*

Footnotes:

- Make sure all forces are in **compatible units** before adding. For example, convert kips to pounds or N to kN as needed so that you don't add apples to oranges.

- The **direction angle** of the resultant is typically measured from the positive x-axis (or horizontal line) with counterclockwise as positive. On the exam, watch the quadrant: if ΣF_x is negative, the basic $\arctan(\Sigma F_y/\Sigma F_x)$ needs adjustment (add 180°) to get the true direction.

- For **concurrent forces** (all acting through the same point), you can safely find one resultant. If forces do not concur (parallel but separate lines of action), you can still add them as vectors for net force, but their **net moment** effect will need separate consideration (see force-couple systems later).

Variations and Related Forms: In three dimensions (not common in FE Mechanical statics problems), you would include a z-component as well and use 3D vector addition. If all forces are **collinear** (along the same line), the resultant magnitude is just the algebraic sum (taking care of signs for direction). If forces are at **90° to each other**, the resultant magnitude simplifies to $\sqrt{F_1^2 + F_2^2}$ for two forces. These are just special cases of the general resultant formula. Remember that the methods of resolving forces into components and then recombining apply to **any number** of forces.

Special Notes (Calculator hints): When computing a resultant on the exam, use your calculator's square root (√) and arctan functions. For example, on a TI-36X Pro, you might input:

$$\sqrt{(\Sigma F_x)^2 + \left(\Sigma F_y\right)^2}$$

for the magnitude. Ensure your calculator is in **degree mode** if the problem asks for an angle in degrees. Use parentheses generously to avoid order-of-operations errors (especially under the square root). There's no direct "vector sum" button, so you'll be doing these operations step by step.

Equation Passport – Resultant of Coplanar Forces

Name and purpose: Resultant Force in Two Dimensions – finds a single force vector equivalent to multiple coplanar forces. This gives the net force (magnitude and direction) acting on a body.

Equation (magnitude):

$$F_{\text{res}} = \sqrt{(\sum_{i=1}^{n} F_{x,i})^2 + (\sum_{i=1}^{n} F_{y,i})^2}$$

Resultant direction: $\theta = \arctan \frac{\sum_{i=1}^{n} F_{y,i}}{\sum_{i=1}^{n} F_{x,i}}$, measured from the x-axis (ensure proper quadrant).

Variables and units:

- F_{res} – Resultant force magnitude (SI: newton (N); US Customary: pound-force (lbf)).
- $F_{x,i}, F_{y,i}$ – Components of the ith force in the x and y directions, respectively (N or lbf).
- θ – Angle of resultant measured from positive x-axis (degrees or radians).

Assumptions and scope:

- All forces lie in a *plane* (2D problem). The formula assumes orthogonal axes (usually horizontal x and vertical y).

- Forces are added as free vectors. If they are **concurrent** (acting through one point on a rigid body), this resultant can be applied at that point with no additional effects. If forces are distributed on a body (non-concurrent), the resultant force gives correct net translation effect, but remember a separate net moment may arise (addressed in force–couple systems).

- We assume a **static context** or just a snapshot in time – we're not yet considering any acceleration or dynamics (this is just summing forces).

Limit tests (sanity checks):

- If one of the forces is zero, the resultant should obviously reduce to the magnitude/direction of the other forces (no bizarre behavior as a force → 0).

- If all forces point in exactly the **same direction**, the resultant's magnitude is just the arithmetic sum of their magnitudes (e.g. 5 N + 7 N in the same line = 12 N total, and the angle is the same as each). The formula reflects this: $\sum F_x = 12$ N, $\sum F_y = 0$, so $F_{\text{res}} = 12$ N, angle 0°.

- If two equal-magnitude forces act in **opposite directions**, we expect them to cancel. Indeed, say one is +10 N (to the right) and another is −10 N (to the left). Then $\sum F_x = 0, \sum F_y = 0$, giving $F_{\text{res}} = 0$. A zero resultant is a valid result – it means complete balance. This check reassures that the formula properly accounts for direction (not just adding magnitudes blindly).

Use vs. related principles: Use this 2D resultant formula *instead of* simply adding magnitudes whenever forces are not collinear. It should be your go-to method for net force in any static problem with multiple forces at angles. If forces extend into 3D (with z-components), you would extend the formula under the square root to include $(\sum F_z)^2$. But for FE Mechanical exam purposes, most force resultants are in a plane. **Do not confuse** this with computing a resultant *moment* (which is a separate concept – see the next subtopic). For concurrent force systems (forces through one point), this resultant fully replaces all the forces. For non-concurrent systems (forces at different points), use this formula for net force but handle moments separately (equivalent force-couple system).

Common exam traps:

- **Ignoring directions:** A frequent mistake is to add all force magnitudes without regard to their directions (signs). For example, if one force is to the right (+) and another to the left (−), adding magnitudes gives a wrong nonzero result. Always resolve into components with proper positive/negative signs based on a chosen coordinate direction.

- **Quadrant mix-ups:** When using $\theta = \arctan(\sum F_y / \sum F_x)$, remember that calculators return an angle between $-90°$ and $+90°$ (for the principal arctan value). If $\sum F_x$ is negative, add 180° to get the correct direction in standard position. A quick mental check of the signs of $\sum F_x, \sum F_y$ will tell you what quadrant the resultant should be in.

- **Unit inconsistencies:** Ensure all forces are in the same unit system before summing. Don't add a 100 N force to a 100 lbf force directly. Convert one appropriately (100 lbf ≈ 445 N) or keep them separate for different equations. Similarly, if forces are given in kN and N, convert kN to N by multiplying by 1000, etc., before plugging into the formula.

- **Forgetting the resultant's location:** In pure particle mechanics, you don't need location. But for rigid bodies, remember that while the net force can be found by this formula, you might also need where that net force acts or any moment it creates about a point. If the problem involves a plank or beam with forces at different points, after finding F_{res} you'll likely proceed to find its point of application (by taking moments).

K06.T01.S02 – Moment of a Force About a Point and Equivalent Force–Couple Systems

Principle Introduction: *A force can not only translate a body but also rotate it about a point.* The **moment of a force** (often called torque) measures the twisting effect of a force about some reference point or axis. It's calculated as the product of the force and the **perpendicular distance** from the point to the force's line of action. We use moments to understand and ensure rotational balance. In statics, any group of forces can be represented by a **force–couple system** – basically a single resultant force acting at a chosen point plus a **couple moment** that accounts for any rotation the original system caused.

- **Moment = force × distance:** The basic concept is *leverage*. A small force can cause a big rotation if applied far from the pivot (think of using a long wrench to loosen a bolt). The moment M about a point O from a force F is $M_O = F \times d$, where d is the shortest (perpendicular) distance from O to the line of action of F. This is essentially the definition of the moment's magnitude in 2D.
- **Vector definition (right-hand rule):** Moment is a vector: $\mathbf{M} = \mathbf{r} \times \mathbf{F}$. The direction of **M** is perpendicular to the plane containing **r** and **F** (for planar problems, into or out of the page). Using the right-hand rule, a counter-clockwise tendency is often taken as positive (out of page), and clockwise as negative (into page) for sign convention in 2D problems.
- **Couple forces:** Two equal and opposite forces not collinear create a pure moment (a **couple**). A couple's moment is $M = F \times d$ (with d being the separation distance between the forces). This moment is free (does not cause translation, only rotation) and can be applied anywhere on a body with the same effect.

- **Equivalent force–couple system:** You can shift a force to a different point, but you must add a corresponding moment to compensate. In practice, any set of forces can be reduced to: (a) a single resultant force (the vector sum, as in S01) acting at a chosen reference point, and (b) a resultant **couple moment** which is the sum of moments of all original forces about that reference point. This pair – one force + one moment – produces the same net external effect on a rigid body as the original system did.
- **Varignon's Theorem:** A useful idea: the moment of a force about a point is equal to the combined moments of its component forces about that same point. So, you can break forces into components to find moments more easily (e.g. $M_O = F_x \cdot y + F_y \cdot x$ for a force with components F_x, F_y at coordinates (x, y) relative to O, taking counter-clockwise as positive).

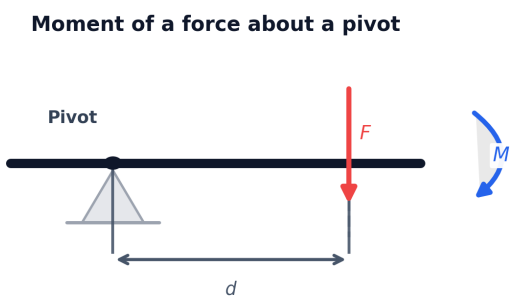

Illustration: Moment of a force about a point. A force F acts downward at a distance d from a pivot point on a beam. This force tends to rotate the beam clockwise about the pivot. The **moment** is $M = F \cdot d$. The diagram shows d as the horizontal distance (lever arm) to the force's line of action, and a curved arrow indicating the rotational tendency (moment) created. If this force were moved closer to the pivot (smaller d), the moment would decrease; if moved farther, the moment increases. If two equal forces F and $-F$ were applied (one up, one down) at two points, they would form a couple with moment $M = F \cdot d$, causing rotation without net force.

Exam Handbook Search Cues (Not affiliated with or endorsed by NCEES): *moment, couple, cross product, Varignon, equivalent force system*

Footnotes:

- **Units:** Moments are in force × distance units (SI: N·m, US: ft·lb or in·lb). Don't confuse these with energy units (also N·m, Joules) – context matters: in statics, N·m is a moment (vector), not energy. For US units, be careful: 1 ft·lb (force) is not the same as 1 lb·ft (some contexts interchange notation, but it's the same unit just written differently). In the exam reference, you might see moments in ft·lb.

- **Sign convention:** Decide on a positive moment direction (typically counter-clockwise, CCW, is positive in 2D problems). Then a force causing clockwise (CW) rotation about the point would have a negative moment. In vector form, if out-of-page is positive M_z, then CCW forces give positive M_z. Keeping signs straight is critical when summing moments for equilibrium.

- **Force line of action:** The perpendicular distance d is *not* just the physical distance between point and where force is applied – it must be measured at 90° to the force's direction. If a force is not perpendicular to the lever arm, use $d_\perp = r\sin\phi$ (or $M = F \cdot r\sin\phi$), where r is straight-line distance from point to force and ϕ is angle between r and F. It's often easier to break the force into perpendicular and parallel components relative to the line from the point. Only the perpendicular component causes moment.

Variations and Related Forms: The moment concept extends to **torque in shafts** (same math, different context) and to 3D where $\mathbf{M} = \mathbf{r} \times \mathbf{F}$ gives a moment vector. A special case: if a force's line of action passes through the point in question, $d = 0$ so it produces **zero moment** (it won't cause rotation about that point). This is why in equilibrium analysis we often choose a moment center at a support through which an unknown force passes – that force then drops out of the moment equation. **Couples** are a variation where two forces create a moment independent of reference point. For a **pure couple**, the net force is zero but net moment is constant everywhere. In calculations, you might replace a distributed load by a resultant force and a couple (if needed) to maintain equivalence at a different point. Varignon's theorem (as mentioned) is a related useful tool: it lets you sum moments of components instead of the original force – good for breaking angled forces into perpendicular lever arms.

Special Notes (Calculator usage): Calculators won't directly give you a cross product, but they can handle the arithmetic: for 2D moments, you'll typically multiply a force by a distance. Just be careful with the sign. If you treat clockwise as negative, then when you multiply $F \times d$ for a clockwise action, attach a minus sign. Some exam problems might require computing a moment given force coordinates: e.g., $M_O = xF_y - yF_x$ (from the determinant formula of cross product). Ensure you plug in numbers in the correct order. It might help to sketch a quick diagram and indicate CW/CCW by arrows, then decide the sign before computing. For equivalent force-couple systems, you'll compute a resultant force (S01) and a resultant moment. There isn't a one-step keystroke for that; do it piecewise: sum forces, sum moments.

Equation Passport – Moment of a Force & Force–Couple Equivalence

Name and purpose: Moment of a Force – calculates the rotational effect (torque) of a force about a specified point or axis. Also establishes how to form an equivalent force–couple system. This is used to find support reactions, design lever arms, and simplify complex force systems to a single force + moment.

Equation (vector form): $\mathbf{M} = \mathbf{r} \times \mathbf{F}$. (Scalar 2D form):

$$M = F\, d_\perp$$

Here $d_\perp$ is the perpendicular distance from the point to the force's line of action.

Variables and units:

- **M** – Moment vector (N·m or lbf·ft). Direction by right-hand rule (e.g. $+\mathbf{k}$ out of page for CCW in plane).
- M – Scalar moment magnitude about a point (N·m or ft·lb). Positive/negative indicates direction (CCW/CW) by convention.
- **r** – Position vector from the reference point to any point on the force's line of action (m or ft). In 2D, **r** often expressed as $\langle x, y \rangle$.
- **F** – Force vector (N or lbf), applied at the tail of **r**. For 2D, $\mathbf{F} = \langle F_x, F_y \rangle$.
- $d_\perp$ – Perpendicular distance from the reference point to the line of action of F (m or ft). Sometimes denoted simply d.

Assumptions and scope:

- The body is rigid (so forces anywhere on it can be moved with couples without deforming). Statics assumes rigid bodies.
- The formulas are **general**: valid for any force and any reference point. In 3D, the full cross product must be used to get direction. In planar problems, we typically take moments about a point and get a scalar (out-of-plane z-component of $\mathbf{M}$).

- When summing moments from multiple forces, they all must be calculated about the *same* reference point for consistency.

- A **force–couple system** equivalence means: if you have a resultant force $\mathbf{F}_{res}$ (from S01) located at a reference point, you must add a **couple moment** M_{res} equal to $\sum(\mathbf{r}_i \times \mathbf{F}_i)$ to represent all the moments the original forces had about that point. This representation is valid for rigid bodies in statics (the external effects on the body are the same).

Limit tests (sanity checks):

- If $F = 0$, obviously $M = 0$. No force, no rotation.

- If the force's line of action goes directly through the reference point (meaning $d_\perp = 0$), then $M = 0$. This checks out: a force through the pivot doesn't cause rotation (think of pushing at the hinge of a door – it won't make the door rotate).

- If we increase the force or the lever arm, the moment increases linearly. Double the force → double the moment. Double the distance → double the moment. There's no weird non-linear effect, which fits our physical intuition of leverage.

- For a given couple (two equal opposite forces), if you slide them closer (smaller d), the moment decreases; if you slide them farther apart, moment increases. If $d = 0$ (forces on top of each other), you effectively have equal/opposite forces at the same line – which cancel out (zero net force and zero net moment).

Use vs. related principles: Use the moment formula whenever you need the **rotational influence** of a force. On the FE exam, you'll use moments extensively to compute support reactions (choose a point, sum moments = 0 to solve for unknown forces), to find internal bending moments, or to check if a system is balanced. Use the cross product form if dealing with coordinates or 3D vectors; use $M = Fd$ if the geometry in 2D is straightforward. **Compare to equilibrium:** the moment by itself doesn't tell you if something is in equilibrium, but in equilibrium problems you set the *sum* of moments to zero. **Do not use** these formulas for energy or work calculations (even though the units look like energy units); use them strictly for static force systems. If you have multiple forces, you can compute each force's moment about a point and sum them: $M_{\text{tot}} = \sum F_i d_{i,\perp}$. If you need to move a force to a different point (to form an equivalent system), calculate the moment of that force about the new point and include it as a free couple. For example, moving a force F by a perpendicular distance d generates an added moment $M = Fd$. This is exactly what an "equivalent force–couple system" means: you relocate the force and account for its moment.

Common exam traps:

- **Mixing up distance in moment calculation:** You must use the perpendicular distance. Students sometimes plug in the straight-line distance from point to application, which is larger than the lever arm if the force isn't perpendicular. If a force is at an angle, remember $M = F \cdot d_\perp = F \cdot r\sin\phi$. A classic mistake is to use r when they should use $r\sin\phi$. Drawing the right triangle of forces can help identify the correct lever arm.

- **Wrong direction (sign errors):** It's easy to miss a negative sign. For instance, if you assume CCW moments positive, and you have a force that clearly causes clockwise rotation about the point, its moment should be negative. Forgetting this sign convention can lead to incorrect equilibrium equations. Always visualize or sketch an arrow curving in the direction the force tries to rotate the body, then assign the sign.

- **Forgetting to include all forces when summing moments:** In an exam hurry, you might drop a term. A common one is neglecting a weight force's moment or a reaction force's moment. Train yourself to systematically include every force in the moment summation, perhaps by writing out each term in a tidy list.

- **Assuming a force–couple system is unique without specifying reference point:** Remember, the moment value in the force–couple pair depends on the reference point. If the problem asks for an equivalent force-couple system, you must state "about point O" or whichever point you choose. A different point yields a different couple moment (because d changes). Only a pure couple (two equal opposite forces) has the same moment about any point. For a general system, always clarify the reference for your equivalent moment.

K06.T01.S03 – Reduction of Distributed Loads into Resultants (Uniform Load Resultant)

Principle Introduction: *Distributed loads* (like a uniform pressure or load spread along a beam) can be **simplified by replacing them with a single concentrated force** that has the same net effect. This process is called reducing a distributed load to a **resultant**. For example, a beam supporting a uniformly distributed load (UDL) can be analyzed by converting that continuous load into one resultant force equal to the total load, applied at the centroid of the distribution. Key ideas:

- **What is a distributed load?** Instead of a single force at a point, a distributed load is spread out over an area or along a length. In 1D (along a beam), it's often given as w (force per unit length, e.g. N/m). A uniform load means the intensity w is constant across the span.
- **Resultant force = area under load curve:** The total force resulting from a distributed load is the **integral** of the load over its length (or area under the loading diagram). In simple terms for uniform loads, just multiply the intensity by the length: $R = w \times L$. This gives one equivalent force representing the entire distributed load.
- **Line of action through centroid:** The single resultant force acts at the *centroid* (geometric center) of the load distribution. For a uniform load over a simple span, the centroid is at the midpoint. So the resultant is placed at the middle of that span. (If the load is not uniform, you'd find the centroid of the shape formed by the load curve to position the resultant.)
- **Purpose of reduction:** By replacing the spread-out load with one force, we drastically simplify equilibrium calculations. We can easily compute support reactions or internal forces using that one resultant instead of integrating or summing infinite small forces. On exam day, you'll often immediately replace a UDL with its resultant to solve for moments and forces.
- **Uniform vs non-uniform:** While this subtopic focuses on **uniform** distributed loads (constant w), keep in mind

that other common distributions (triangular, trapezoidal) also have known centroid locations and resultants (e.g. a triangular load's resultant is $R = \frac{1}{2} w_{\max} L$ and acts at $L/3$ from the thick end). The uniform case is the simplest and most frequently tested.

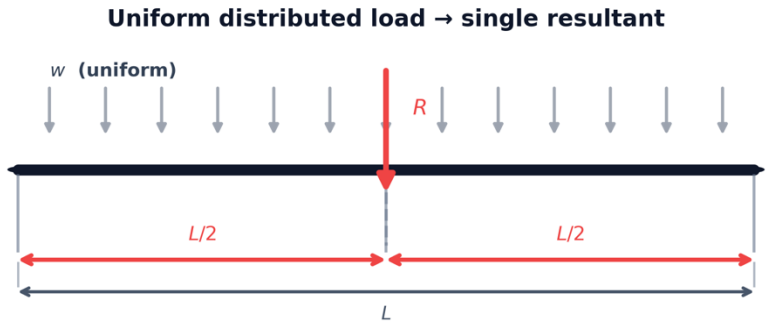

Illustration: Replacing a uniform distributed load with a single resultant. A beam is subjected to a uniform load w. The total force from this load is $R = w \cdot L$. This resultant is placed at the midpoint of the load's span (i.e. at $L/2$ from either end). The horizontal arrows' couple indicates the half-length $L/2$. By using this single force R in calculations, we get the same support reactions and overall effect as the original continuous load.

Exam Handbook Search Cues (Not affiliated with or endorsed by NCEES): *distributed load, uniform load, load resultant, centroid*

Footnotes:

- **Units check:** If w is given in, say, kN/m and the length L in m, then R comes out in kN. If w is in lb/ft and L in ft, R is in lb. Always perform this mental check: multiplying a distributed load by length should yield a force unit.

- **Centroid vs. Center of Gravity:** In this context, centroid of a load distribution is analogous to center of gravity for a weight distribution. For uniform density along a length, the centroid is at the geometric center. If a load isn't fully covering a beam (say only a portion is loaded), the resultant lies at that portion's midpoint, *not* the midpoint of the entire beam.

- **Boundary conditions:** If a distributed load does not span the whole member (e.g., a partial uniform load on one side of a beam), make sure to use the length of that portion for L and measure the $L/2$ from the correct start of the load. The resultant force only represents the part of the beam that has the load.

- **Distributed vs. Concentrated loads:** Reducing a distributed load to a resultant is valid for computing external effects (support forces, overall equilibrium). However, internally (like bending moment diagrams), the distribution matters. For instance, the maximum bending moment under a uniform load is different in shape than that from a single concentrated load at midpoint, even though both have same total force and support reactions. The exam usually focuses on equilibrium and reactions, where using the resultant is appropriate.

Variations and Related Forms: For a **triangular load** (zero at one end, peak w_0 at the other), the resultant is $R = \frac{1}{2} w_0 L$ and it acts at one-third from the peak end (since the centroid of a triangle is at 1/3 its base from the larger end). For a **trapezoidal load**, you can break it into a uniform part and a triangular part or use the formula for the area of a trapezoid and its centroid. These are more complex but follow the same principle: find total area (force) and centroid. In general, $R = \int_0^L w(x)\, dx$ and the location x_R satisfies $x_R = \frac{1}{R} \int_0^L x\, w(x)\, dx$. The FE Reference Handbook provides centroid locations for common shapes which correspond to these load distributions. Typical values: centroid of a rectangle (uniform) at 0.5L, triangle at 1/3L (from base), semicircle at 4R/(3π), etc. – but for statics loads, rectangles and triangles are most relevant.

Special Notes (Calculator tips): Usually calculating $R = w \times L$ is straightforward on any calculator. Just be cautious with unit conversions if needed (you might do w in kN/m and L in m to get R in kN, or convert everything to base units). If dealing with a triangular load, you may need to multiply 0.5 * base * height. The Casio or TI calculators handle this fine – just remember to include the 0.5. For locating the resultant, if you have to compute a third of the length, multiply by the fraction directly (e.g. L * (1/3) or 0.3333 * L). It's wise to use the fractional form to avoid rounding too much. Always identify from which end you're measuring; on a diagram mark "x=0" at a convenient reference (usually one end of the beam) and measure the centroid distance from there.

Equation Passport – Uniformly Distributed Load Resultant
Name and purpose: Resultant of a Uniform Distributed Load – replaces a continuous load spread over a length with an equivalent single force for equilibrium and design calculations. Simplifies support reaction and moment calculations.

Equation: $R = w\,L$. *(Applied at the load's midpoint: at $L/2$ from either end of the uniform load span.)*

Variables and units:

- R – Resultant (total force from the distributed load, N or lbf).
- w – Uniform load intensity (force per unit length, e.g. N/m or lbf/ft). Sometimes noted as q in texts, but w is common in structural contexts.
- L – Length over which the load acts (m or ft). In a simply-supported beam scenario, this could be the span length if the load covers the whole span.

Assumptions and scope:

- The load is **uniform** over the length L; that is, w is constant. (If w varies with position, this formula doesn't directly apply; you'd integrate or use piecewise areas.)

- The load acts in one direction (e.g. all downward). We assume it's distributed along a straight line (one-dimensional distribution on a beam).

- The body is rigid and the support conditions don't significantly alter the distribution (for simply calculating the resultant, support type doesn't matter—this is just a load property).

- We are concerned with the **external effects**: using R will give correct support reactions and overall equilibrium results. (Internal distribution of stress may require considering the full distribution, but that's a mechanics of materials concern.)

Limit tests (sanity checks):

- If $w = 0$, obviously $R = 0$. No load means no resultant force.
- If the load covers **zero length** ($L \to 0$), then $R = w \cdot 0 = 0$. This is consistent: an infinitesimally small patch of load carries negligible total force.
- If you double the load intensity w (keeping L same), the resultant doubles – linear scaling, which makes sense. Likewise, doubling the span L (with same w) doubles the total force. More area under the load = more total force, no surprises.
- Check extreme placement: if only half the beam has a uniform load and the other half is unloaded, using $R = wL_{loaded}$ located at that half's midpoint should match intuition (the other half contributes nothing). And if the entire beam is loaded, resultant at midspan is logical by symmetry.
- When comparing to a concentrated load case: If the entire load R were somehow all at one point, the support reaction sum would still equal R. So at least for global equilibrium, the replacement is valid. The distribution's effect only shows up if you ask "where is the moment max?" etc., but that's beyond just finding the resultant.

Use vs. related principles: Use this formula to collapse a uniform load in statics problems before writing equilibrium equations. It's especially handy for finding reaction forces: replace the distributed load with R at midpoint, then do $\Sigma M = 0$ about a support, etc. This formula is a specific case of the more general concept of finding the **area under the load curve**. For non-uniform loads, either integrate $R = \int w(x)dx$ or remember standard results (like triangle or trapezoid as noted). If you have multiple separate distributed loads on one structure, reduce each to a resultant, then treat those resultants plus any point loads together in equilibrium equations. **Do not confuse** a distributed load with a pressure on an area (though conceptually similar). For pressure over an area (in fluids or soil), you'd use the area times pressure for resultant and the centroid of pressure for location – analogous process but 2D surface instead of a 1D line load. In all cases, you're converting a "spread-out" load into a single force for easier handling.

Common exam traps:

- **Forgetting to include the load's full length:** Sometimes a problem will have a uniform load only on part of a beam. You must use that exact length for L. If the uniform load doesn't span the entire beam, don't erroneously use the whole span in wL. Use the portion where the load actually is.

- **Misplacing the resultant:** A very common error is putting the resultant at the wrong location. For a uniform load across an entire simply supported beam, it should go at midspan. If you put it elsewhere (say at 1/3 or something), your moment equilibrium will be off. Likewise, for a triangular load, the resultant goes at 1/3 from the larger end, not at the midpoint. Students often mix these up under time pressure. To avoid this, remember: *uniform = middle*, *triangle = one-third from heavy end*.

- **Mixing units in wL:** Ensure consistency. If w is given in kN/m and length in **meters**, R will be in kN. If length was given in **feet** but w in kN/m, you'd need to convert one or the other (either convert length to meters or convert w to kN/ft) before multiplying. Watch out especially in mixed-unit practice problems.

- **Assuming the resultant makes internal shear/moment identical to original load:** Using the single resultant for equilibrium (external forces) is fine, but if a question asks about internal shear or bending distribution, you cannot just replace the load by one force for that part. The question might not explicitly say it, but if it's about, e.g., "maximum bending moment under the load," you need to treat it as distributed when drawing the shear/M diagram or use formulas for distributed loads. The resultant trick is mainly for equilibrium calcs.

- **Not recognizing a distributed load in words:** Sometimes exam problems describe a load in words like "a 5 kN/m load over the entire 3 m beam". It's up to you to interpret that as $w =$ 5 kN/m, $L = 3$ m and immediately think: "Okay, that's a total of 15 kN acting at 1.5 m from one end." Practice translating such descriptions into $R = wL$ form quickly.

K06.T01.S04 – Equilibrium Requirements for General Force Systems (Net Force and Net Moment = 0)

Principle Introduction: *Equilibrium* is the condition of a system with no unbalanced forces or moments – in other words, the system is **stable and at rest or moving with constant velocity** (no acceleration). For statics (our focus), we consider bodies at rest. The requirements for equilibrium in a general force system are straightforward: the **sum of all forces must be zero** (so no net push in any direction) **and the sum of all moments about any point must be zero** (so no net rotation). These conditions ensure the object isn't translating or rotating. On the FE exam, equilibrium equations are your main tool for solving unknown forces (support reactions, tensions, etc.) in statics problems.

- **Newton's First Law (statics form):** If an object is in static equilibrium, $\Sigma\mathbf{F} = \mathbf{0}$ and $\Sigma\mathbf{M} = \mathbf{0}$. That means every force is balanced by another force, and every clockwise moment is balanced by a counter-clockwise moment.
- **Component equilibrium:** In 2D, we break the force balance into two components (typically horizontal and vertical). So we write $\Sigma F_x = 0$ and $\Sigma F_y = 0$. This covers no net force horizontally and no net force vertically. Likewise, choose a point (often conveniently a support or intersection of unknown forces) and write $\Sigma M = 0$ about that point. That covers the no net moment condition. In 3D, there would be three force equations ($\Sigma F_x, \Sigma F_y, \Sigma F_z = 0$) and three moment equations ($\Sigma M_x, \Sigma M_y, \Sigma M_z = 0$).
- **Free-Body Diagram (FBD):** The equilibrium conditions are applied to a diagram showing all forces and moments on the isolated body. Drawing a correct FBD is half the battle – it ensures you include all forces in the sums. Each support or connection contributes forces (and possibly moments) that you include as unknowns.

- **Static determinacy:** If you have as many independent equations as unknown forces/moments, you can solve for the unknowns. In planar statics, you generally have up to 3 independent equilibrium equations (two force equations and one moment equation). If a structure has more support unknowns than equations, it's statically indeterminate (not solvable by statics alone). The FE won't usually ask you to identify determinacy, but it's good to be aware: if an equilibrium problem seems unsolvable with the given info, it might be indeterminate (needing additional methods like deflections which are beyond simple statics).
- **General force systems:** The term implies forces need not be concurrent or parallel; they can be anywhere. The equilibrium conditions still apply globally. Often, you'll take moments about a particular point to eliminate one or two forces from the equation (because their moment arm is zero about that point). This is a standard tactic for solving support reactions: sum moments about one support to find the other support's force, etc.

Exam Handbook Search Cues (Not affiliated with or endorsed by NCEES): *equilibrium, sum of forces, sum of moments, ΣF = 0, ΣM = 0*

Footnotes:

- **Static vs. Dynamic:** These equations only apply for static (or steady constant velocity) scenarios. If the problem hints at acceleration or motion, then you're in dynamics territory (where $\Sigma F = ma$ instead, not zero). But for the FE Mechanical exam, any question labeled under Statics expects $\Sigma F = 0$ and $\Sigma M = 0$.

- **2D vs. 3D:** In planar problems, we often denote $\Sigma M_z = 0$ as just $\Sigma M = 0$ (implying moments out of the page are zero). In 3D, you'd have separate moment equilibrium about x, y, z axes. The FE Mechanical is primarily concerned with 2D rigid body equilibrium, so use the 3-equation set. If a problem does involve 3D (rare in FE statics), approach similarly with 6 equations.

- **Support conventions:** Know what reaction forces/moments supports can provide. For example, a pin support gives two reaction force components (but no moment reaction), a roller gives one vertical reaction (no horizontal, no moment), a fixed support gives two force components and a moment. When writing $\Sigma F = 0$ and $\Sigma M = 0$, include only the appropriate reaction components. If you assume a wrong type of reaction, your equilibrium won't match reality.

- **Moments about different points:** If $\Sigma F = 0$ is satisfied and $\Sigma M = 0$ about one point is satisfied, then $\Sigma M = 0$ about any other point *will also* be satisfied (for a rigid body). Practically, you can choose the most convenient point for moment equilibrium (often eliminating unknowns). Don't feel you have to write moment equations about multiple points unless you need to solve different unknowns – one point's moment equation plus the force equations are enough.

Variations and Related Forms: In some equilibrium problems, you might write $\Sigma M_A = 0$ and $\Sigma M_B = 0$ about two different points instead of $\Sigma F_x = 0$ or $\Sigma F_y = 0$, if you find it easier (for instance, to directly solve two unknown forces by two moment equations). That's valid as long as the axes are not parallel (essentially, you're doing the same thing in another way, because two independent moment equations about two points can replace the two force equations when geometry permits). Another scenario: **concurrent force systems** (all forces through one point) have no moment equation needed for that point (since all forces pass through it, $\Sigma M = 0$ is automatically satisfied about that point). In such cases, you rely on just $\Sigma F_x = 0, \Sigma F_y = 0$ to find unknowns (common for particle equilibrium problems or joint method in trusses). For **parallel force systems** (e.g., all vertical forces on a beam), one force equation (vertical) and one moment equation are effectively used (horizontal force equation is trivial). The core equilibrium principle is the same, just applied in a reduced form. Also, remember equilibrium can be applied to a whole structure or any part of it you isolate (subsystem equilibrium or section cut free-body). This is the basis of methods like sections in trusses or analyzing individual members. The equations remain $\Sigma F = 0, \Sigma M = 0$ for that free-body as well.

Special Notes (Using the calculator wisely): Solving equilibrium equations on the calculator is about solving linear equations. Often, you'll set up two or three linear equations. For example, you might have $A + B = 50$ (from $\Sigma F_y = 0$) and $4A + 8B = 300$ (from $\Sigma M = 0$, where 4 and 8 are distances of forces A and B from a moment center). Solving these is easiest by simple substitution or elimination by hand. Some FE-approved calculators (like the TI-36X Pro) have a linear equation solver for 2x2 or 3x3 systems, which can save time. If you're comfortable, you can input the coefficients and get the unknowns directly. But be cautious: ensure you've input the equations correctly. It's often just as fast to do a quick manual solve for 2 equations. For three equations (in 3 unknowns), the solvers are more helpful. Also, double-check your solutions by plugging back into all equations—particularly sign-sensitive ones like moments. A small arithmetic mistake can lead to a support reaction that doesn't actually balance moments. Always do a mental or quick check: do the forces roughly balance? Do the moments from left and right seem to cancel? This gut check can catch entry errors on the calculator.

Equation Passport – Equilibrium Conditions
Name and purpose: Equilibrium Equations (Rigid Body in Planar Statics) – ensure that a system of forces and moments is balanced (no net acceleration). These equations are used to solve for unknown support forces, check if a design is stable, and confirm that all forces/moments have counterparts.

Equations (2D):

$$\Sigma F_x = 0, \qquad \Sigma F_y = 0, \qquad \Sigma M_O = 0.$$

(The moment equation can be about any reference point O; choose conveniently.)

Variables and meaning:

- $\Sigma F_x = 0$ – Sum of all force components in the x-direction equals zero. This means forces to the right = forces to the left, net horizontal force is nil. (Units: N or lbf; essentially, it's an equation stating some number of N = 0.)
- $\Sigma F_y = 0$ – Sum of all force components in the y-direction equals zero. Upward forces balance downward forces, no net vertical push.
- $\Sigma M_O = 0$ – Sum of moments about point O equals zero. Clockwise moments balance counter-clockwise moments, no net rotation about that point. The choice of O is arbitrary for a body in equilibrium; if this holds for one point and forces sum to zero, it holds for all points. (Units: N·m or ft·lb for the sum; conceptually it sets an equation like X N·m = 0.)

Assumptions and scope:

- The object is rigid and **static** (not accelerating). These equations stem from Newton's laws assuming acceleration $a = 0$ and angular acceleration $\alpha = 0$.

- All **external forces and moments** acting on the free-body are included in the summations. (Internal forces between parts of the body cancel out and don't appear if you take the whole object as FBD.)

- We assume a consistent coordinate system and sign convention for forces (e.g., $+\hat{\imath}$ to the right, $+\hat{\jmath}$ upward) and for moments (e.g., + for CCW). Once set, we stick to it for all terms in the equations.

- These equations apply to a single isolated body or a system considered as a whole. If analyzing part of a structure, you draw an FBD of that part and then apply equilibrium equations to it as well – the form is the same but the force set will differ.

Limit tests (sanity checks):

- If even one of these sums is not zero, the body isn't in equilibrium. For example, if $\Sigma F_x = 1000$ N instead of 0, that implies $ma_x = 1000$ N and the body accelerates (not static). So equilibrium failed. Thus the "limit" here is basically zero – any nonzero result breaks equilibrium.

- Consider special cases: A **particle** (no size, all forces concurrent) cannot sustain a moment, so equilibrium for a particle only requires $\Sigma F_x = 0, \Sigma F_y = 0$. That's consistent with our general rule (moments trivial if no distances). A **rigid body** with parallel forces (like a beam with only vertical loads) will have $\Sigma F_x = 0$ automatically (nothing horizontal) and requires $\Sigma F_y = 0, \Sigma M = 0$. That fits the general equations with some being moot.

- If you find a solution for support forces that satisfies $\Sigma F = 0$ but not $\Sigma M = 0$ (or vice versa), something is wrong: either the setup (supports or loads assumed) is incorrect or arithmetic mistake. Always verify all applicable equilibrium equations are satisfied by your answers – for a valid static solution, they must all be exactly zero.

Use vs. related principles: These equilibrium equations are **the foundation of all statics problem solving**. Use them whenever you have unknown forces or moments to find. For instance, to find how much force a pin support and a roller support carry under a loaded beam, you write $\Sigma F_y = 0$ and $\Sigma M = 0$ to solve for those two unknowns. There isn't really an "alternative" to equilibrium equations – they are it, derived from Newton's laws. However, be aware of **supplementary methods**: if a structure is indeterminate (more unknowns than equations), you cannot solve with just these; you'd need deflection equations or material properties (that's beyond FE statics). In contrast, if a system is fully determined by statics, these three equations (or fewer, depending on dimensions) are all you need. In summary, use equilibrium equations for any static analysis instead of trying to apply kinematic or dynamic formulas (which would be incorrect in a static scenario). If you find yourself thinking about $F = ma$ or energy methods, stop – likely, the FE statics problem just needs $\Sigma F = 0, \Sigma M = 0$.

Common exam traps:

- **Omitting a force in the FBD:** If you forget to include a reaction force or an applied load in your free-body diagram, your ΣF or ΣM equation will be incomplete, leading to a wrong answer. For example, not showing a hinge reaction's horizontal component (if the hinge can provide it) will make $\Sigma F_x = 0$ solvable for fewer unknowns than reality – giving a false result. Always systematically list all forces: weights, loads, support reactions (both x and y components if applicable), and any other external push/pull.

- **Wrong moment arm or axis in $\Sigma M = 0$:** A very common mistake is using the wrong distance for a force in the moment sum. Double-check each term: moment = force × perp distance. If a force is right at the point you take moments about, its distance is zero (it drops out). If a force is angled, use its perpendicular component times distance, or full force times perpendicular distance. Also ensure you're summing moments about the same point for all terms in that equation. Sometimes students mix moments about different points in one equation – that's invalid.

- **Sign inconsistency:** It's easy to mix up signs when equations get complex. For instance, assume up and right are positive. If a support force at A is upward, put $+A$ in ΣF_y. If a weight is downward 200 N, put -200 N. Now for moments, if you take moments about A, a downward 200 N at 3 m to the right causes a clockwise moment which you might consider negative (if CCW is positive). If you plug in the wrong sign for that moment term, you'll get the wrong answer. A tip: before solving, quickly estimate the direction of rotation each force causes about your reference – mark it as + or - on your diagram to guide your equation writing.

- **Solving too many or too few equations:** In 2D statics, you have exactly 3 independent equations. If you write more (say, ΣM about two different points plus $\Sigma F_x, \Sigma F_y$), you might inadvertently be writing an equation that's mathematically dependent on the others (or you might be overconstraining a statically indeterminate problem). If you write fewer, you won't solve all unknowns. Stick to a strategy: usually, use two force balance equations and one moment. If there's no force in one direction (no horizontal forces, for instance), then $\Sigma F_x = 0$ is trivial and you rely on $\Sigma F_y = 0$ and $\Sigma M = 0$.

- **Forgetting that equilibrium applies in any direction:** While the standard approach is x-y, sometimes a problem might be easier if you sum forces in a rotated axis (for example, along a slope) if symmetry suggests it. $\Sigma F = 0$ is true in any direction, so you could project forces onto a convenient axis for a particular problem. Just be careful: using non-orthogonal axes might make the other equation more complex. Generally, stick to perpendicular axes unless there's a clear simplification by rotating axes for one equation.

- **Time management trap:** On exam day, setting up equilibrium equations can take time. A trap is writing down too many intermediate steps or re-deriving things like distances that are obvious. Practice writing concise equations directly from the FBD. Also, if a problem seems to need lots of computation after writing equations, double-check if there's a symmetry or shortcut. For instance, if two supports are symmetric under a symmetric load, you know by symmetry their reactions are equal – you can use that upfront to simplify the math. Recognizing such cues can save precious minutes.

Topic 02 - Concurrent Force Systems

In a **concurrent system**, every force acts along a line that passes through the same point. You can picture all the arrows either starting or ending at one common joint. On the FE Mechanical Exam, many statics problems simplify when forces are concurrent: if all forces meet at one point, you can balance them by ensuring their vector sum is zero, with no net moment about that point. Recognizing concurrency early makes sketching free-body diagrams and writing equilibrium equations easier. Typical questions ask you to find an unknown force magnitude or direction so that a joint or member stays in balance, or to verify that forces given in a diagram are in static equilibrium.

Context: Concurrent forces often appear in problems involving truss joints, pin-connected members, or loads applied at a point. For example, a bracket held by three cables all attached at one eyelet forms a concurrent system. By choosing the intersection as the reference, you only need $\sum F = 0$ (component form or force polygon) to test equilibrium, since $\sum M = 0$ about that point is automatically satisfied. In practice, you *name the forces*, draw their vectors from the common point, and then use geometry or components to set the sum of forces to zero. This focus on intersection keeps the work straightforward on exam day.

K06.T02.S01 – Concurrent Forces (Definition)

- **What it is:** A concurrent force system has all force lines-of-action intersecting at one point. In other words, you can draw all force vectors so they start or end at the same common point.
- **Why it matters:** When forces are concurrent, checking equilibrium requires only that their vector sum is zero – no moments about the intersection point need to be checked explicitly. This dramatically simplifies analysis on the exam. Many FE statics questions hinge on correctly identifying concurrent systems (for example, forces at a pin joint or 2D force polygon problems).
- **Key idea:** If three or more forces meet at a point and balance, they must form a closed "force polygon" (triangle or multi-sided) when added head-to-tail. For two-force members (a special case), the two forces are equal, opposite, and collinear, effectively also a concurrent condition along their single line of action.

Exam Handbook Search Cues (Not affiliated with or endorsed by NCEES): *concurrent, line of action, two-force body, intersection point*. Use these keywords in the exam handbook to quickly find the definition and properties of concurrent force systems.

Footnotes (unit/symbol notes):

- *Forces as vectors:* Each force $\vec{F}_i$ has magnitude and direction; concurrent means all $\vec{F}_i$ share the same intersection point.
- *2D assumption:* Unless specified otherwise, statics problems are planar. In 2D, forces meet on the plane; in 3D problems, concurrency means a common point in space.
- *Zero moment:* Because all forces pass through the reference point, each force produces zero moment about that point ($\vec{r} \times \vec{F} = 0$ if $\vec{r} = 0$). Thus, **only $\sum \vec{F} = \mathbf{0}$** matters for equilibrium.

Variations & special cases:

- *Two-force members:* A rigid member with only two applied forces is in equilibrium only if those forces are equal, opposite, and act along the same line (collinear). This is a trivial concurrent system (their intersection is anywhere along the line).

- *Force polygon:* With three concurrent forces, equilibrium means they form a closed triangle when drawn head-to-tail. More forces give closed polygons. Remember: if the polygon closes, $\sum \vec{F} = 0$.

- *Non-concurrent (compare):* If forces do **not** share a common point, moments must be included and you must use $\sum M = 0$ about a different point. Don't confuse concurrent with merely coplanar or collinear – **concurrent** strictly means intersection.

Explanation & Analysis: When you see forces that meet at a joint or pin, immediately identify them as *concurrent*. Sketch a free-body diagram (FBD) of the body and mark the common intersection point. Label each force vector $F_1, F_2, \ldots$ originating from that point. Then resolve into components: write $\sum F_x = 0$ and $\sum F_y = 0$ (and $\sum F_z = 0$ if 3D), typically with the intersection as the origin. For example, two forces F_1 and F_2 at a point: equilibrium requires $F_1 = F_2$ and opposite direction (a straight line). For three forces F_1, F_2, F_3 at 120° apart, equilibrium means $F_1 \sin(\theta_1) = F_2 \sin(\theta_2)$, etc., often solved by projecting onto axes or using geometry.

Each symbol: F is force (units N or lbf). Angles are measured between force directions (no units). Check units consistency: all forces in N or all in lbf. A common mistake is forgetting to decompose each force into correct direction or mixing units. Also ensure the point chosen is truly the intersection – drawing approximate vectors can mislead if the intersection shifts.

Special note: On exam calculators (Casio FX-115/991, HP 33s/35s, TI-36X/30X), you can directly compute sine/cosine of angles to resolve forces. Remember to set mode for angles (degree/radian) correctly when summing components.

Key takeaway: In a concurrent system, focus on *sum of forces* only. Because all forces intersect, the net moment about that point is zero by definition. Solve problems by closing the force polygon or by $\sum \vec{F} = 0$ component-wise.

Definition Passport:

- **Concurrent Force System –** A group of forces whose lines of action meet at one point, meaning they all pass through the same common point.

- **Exam Impact:** Appears when forces meet at a pin or joint. Use it to simplify equilibrium: only $\sum \vec{F} = 0$ applies (no moment equation needed about the intersection).

- **Pitfall:** Don't call forces concurrent unless they truly share an intersection. Parallel or skew forces are *not* concurrent. Also, avoid forgetting that two-force bodies force lines must align (equal and opposite) even if the intersection is arbitrary.

- **Quick check:** True or False – If three forces on a body all meet at point O, is any net moment about O always zero? **Answer:** True, because $\vec{r} = 0$ for each force at O.

Answer Source: This concept is summarized from the exam handbook (noted here for reference keywords). The content above is original explanatory material aligned with FE Mechanical Statics.

K06.T02.S02 – 2D Equilibrium Equations for Concurrent Forces

- **Key idea:** If a rigid body is in static equilibrium and all forces pass through one point (concurrent), then the net force in each perpendicular direction is zero. You only need force-balance equations (no moment equation).
- **Setup:** Draw a free-body diagram (FBD) of the point or pin where forces meet. Choose horizontal (x) and vertical (y) axes. Resolve each force into F_x and F_y components (using $\cos\theta$, $\sin\theta$ as needed). Then apply equilibrium in each direction.
- **Equations:** The sum of all horizontal components is zero, and separately the sum of all vertical components is zero. In symbols:

$$\sum F_x = 0, \qquad \sum F_y = 0.$$

- **When it applies:** Use these equations whenever forces are concurrent (all through one point) in a plane. In such cases, rotational equilibrium about that point is automatically satisfied, so only these two equations are needed.
- **Conceptual check:** Think of balance scales: if you add a force to the right (positive x), you need equal total force to the left to keep equilibrium, and similarly for up vs down.

Equation Passport – Equations of Equilibrium (2D Concurrent Forces)

Name & purpose: *Equations of Static Equilibrium in 2D* – used to find unknown forces (magnitudes or angles) in a system of concurrent forces by enforcing no net force in horizontal and vertical directions.

Professional equation: $\sum_i F_{x,i} = 0, \quad \sum_i F_{y,i} = 0.$

Variables & units:

- $F_{x,i} : x - component$ of the $i - th$ force (unit: newton (N) or pound-force (lbf)).
- $F_{y,i} : y - component$ of the $i - th$ force (N or lbf).
- (Alternatively, one can use F_i (magnitude) and angle θ_i such that $F_{x,i} = F_i \cos\theta_i$, $F_{y,i} = F_i \sin\theta_i$.)

Assumptions & scope:

- *Planar, static system:* Forces lie in a single plane and the body is stationary (no acceleration).
- *Concurrent:* All force lines-of-action meet at a common point.
- Out of scope: 3D forces (no F_z here) or non-concurrent systems (then include moments).

Limit tests:

- If a force magnitude $F_i \to 0$, that force effectively vanishes and equilibrium reduces to the remaining forces.
- If all forces except one shrink to zero, the remaining force must be zero too (no single nonzero force can be in equilibrium by itself).
- If two forces are present (two-force member), they must be equal in magnitude and opposite (a straight-line "tug-of-war").

Use vs. sibling equation: Use $\sum F_x = 0$, $\sum F_y = 0$ when *all* forces intersect. If forces are non-concurrent, one must also use a moment equilibrium equation ($\sum M = 0$) about some point.

Common exam traps:

- **Sign mix-ups:** Forgetting that $F_x = F\cos\theta$ might be negative if $\cos\theta < 0$. Always assign positive/negative according to your axis directions.
- **Angle reference:** Ensure angles are measured from the correct axis. For example, if θ is given from horizontal, $F_x = F\cos\theta$, but if it's from vertical, you may need $F\sin\theta$.
- **Units & forces:** Don't confuse mass and force (e.g. using lbf vs lbm) – treat F as a force value already (typically N or lbf on FE).
- **Concurrent assumption:** If one force's line of action doesn't actually pass through the point, these equations alone won't hold (you'd need moments).

Exam Handbook Search Cues (Not affiliated with or endorsed by NCEES): Use these keywords in the official exam handbook's search box (not copying text, just to locate topics):

- **"Equilibrium"** – look under statics, see equations
- **"Concurrent forces"** – finds definitions and related sections
- **"Sum of forces"** or **"free-body diagram"** – general cues to relevant formulas.

Footnotes (nuances & scope)

- **Coordinate sign:** You can choose $+\hat{x}$ *and* $+\hat{y}$ in any convenient directions, but once set you must stick with them consistently for all forces. A small sign error (like a minus instead of plus) can kill your answer. Always sketch your FBD with axes and mark +/– directions.
- **Concurrent vs. non-concurrent:** These formulas assume *true* concurrency. If one force misses the common point (even slightly), that force creates a moment and you'd need to include $\sum M = 0$ about the point. In well-posed FE problems, they'll indicate clearly if forces are concurrent (e.g. "all attached at a pin").
- **Units:** The FE exam may use SI (N, m) or USCS (lbf, ft). These equations themselves are unit-consistent in any system – just keep all forces in the same system (e.g. convert all to N or all to lbf before summing).

Variations & Related Forms

- **Component formulas:** Sometimes problems give a force by magnitude and angle. Then use $F_x = F\cos\theta$, $F_y =$

$F \sin\theta$(angle from positive $x - axis$), or $F_x = F \sin\theta$, $F_y = F \cos\theta$ if angle is from vertical. Check drawing.

- **Two-force member:** If exactly two forces act on a body and it's in equilibrium, those two must be collinear and equal/opposite (they form a straight line). This is a special case of $\sum F = 0$.
- **Multiple forces:** With three or more forces, the tip-to-tail polygon (vector sum) can be used; equilibrium means the polygon closes (vector sum = 0). This is just a geometric reinterpretation of $\sum F_x = 0,\ \sum F_y = 0$.
- **3D case:** In 3D concurrency, you also need $\sum F_z = 0$ with a z-component (but that's beyond this 2D topic).
- **Typical magnitudes:** There's no "normal" force value here – it depends on the problem (could be tens of N in small mechanics, kilonewtons in structures). Instead, get comfortable with unit conversion if needed (e.g. converting lbf to N via 1 lbf ≈ 4.448 N).

Special Calculator Notes

- **Trigonometry mode:** Most FE problems give angles in degrees. Ensure your calculator is set to **[DEG]** when using sin, cos. If in radian mode, your answers will be wrong.
- **TI-36X/36:** Use the equation solver (MODE→EQN on TI) or solve manually. When entering something like $\sum F_x = 0$, type e.g. F1*cos(θ1) + F2*cos(θ2) + F3 = 0. Make sure to use parentheses: e.g. (F2), and use the negative sign key (not subtraction from zero).
- **Casio fx-115/991:** Similar approach – use the equation function or solve step-by-step. Input each term carefully, e.g. F1*cos(a)+F2*cos(b)+F3*1=0.
- **Sign clarity:** If a force points opposite to your positive direction, enter it as a negative. For example, a 10 N force pointing left would enter as -10*cos(theta) in the x-sum if you define right as positive.

Explanation & Analysis

When solving a concurrent-force problem, *first sketch and label everything*. Draw the common point (pin/joint) and every force vector emanating from it. Choose a convenient coordinate system (often horizontal right = +x, vertical up = +y).

Next, **resolve forces**: For each force F_i, identify its angle. If θ_i is measured from the horizontal, then the horizontal component is $F_{x,i} = F_i \cos\theta_i$ and the vertical component is $F_{y,i} = F_i \sin\theta_i$. If the angle is given from the vertical, adjust formulas accordingly (or convert θ_i). Write each component with a sign: for example, if a force points left, its x-component will be negative (assuming right is positive).

Then **apply equilibrium**: Write two equations, one summing all x-components, and one summing all y-components. Symbolically, $\sum F_x = F_{1x} + F_{2x} + \cdots = 0, \sum F_y = F_{1y} + F_{2y} + \cdots = 0$.
If there are unknowns (like an unknown force magnitude or angle), these equations form a system to solve.

For example, suppose three cables meet at a ceiling ring: F_1 is known at 30° above horizontal, F_2 is unknown at some other angle, and F_3 is vertical. Your equations will look like $F_1 \cos 30° + F_2 \cos\theta_2 + 0 = 0$ (horizontal) and $F_1 \sin 30° + F_2 \sin\theta_2 + F_3 = 0$ (vertical). From these, you can solve for the unknown force magnitudes and/or their angles.

Term-by-term analysis: In $\sum F_x = 0$, each term $F_{i,x}$ is the x-component of force i. It has units of force (e.g. N). You must take care of its sign (positive or negative) depending on the direction. Similarly, $\sum F_y = 0$ sums the y-components. The symbol $\sum$ means "sum over all forces". For two forces only, these become $F_{1x} + F_{2x} = 0$ and $F_{1y} + F_{2y} = 0$, which implies $F_{1x} = -F_{2x}$ etc., meaning they balance.

Common pitfalls: Students often forget to decompose vectors correctly. For instance, mixing up cos vs. sin for a given angle will give wrong components. Always check which axis your angle references. Another frequent error is sign: if you draw a force pointing left but accidentally add its component as positive, the equation will be off by a sign. To avoid this, write each term with a plus or minus *before* summing. For example, write $+F_{1x} or - F_{2x}$ explicitly in the equation.

Finally, solve the algebra: usually you end up with two linear equations in two unknowns (if there are exactly two unknowns). Use substitution or a calculator's solve function. Double-check the units in your answer (force in N or lbf) and that the numerical result makes sense (positive magnitude, angles in the expected range).

Summary: In concurrent-force problems, "sum of forces equals zero" is your mantra. Break every force into x and y parts, write $\sum F_x = 0, \sum F_y = 0$, and solve. Keep track of signs and units carefully, and remember that the exam's reference will allow you to search for "equilibrium" or "free-body" to refresh the core idea.

K06.T02.S03 – Relationship between Resultants and Equilibrium in Concurrent Systems

Principle introduction:

- **Concurrent system:** All applied forces intersect at one point, forming a "star" of arrows. Each force is represented by an arrow from the center point in its direction (e.g. tension in cables, pin-connected members).
- **Resultant of forces:** The resultant **R** is the single force equivalent to the vector sum of all individual forces: $R = \sum_i \mathrm{b}F_i$.
- **Equilibrium condition:** For a rigid body in static equilibrium under concurrent forces, the resultant must be zero:

$$R = 0 \implies \sum_i \mathrm{b}F_i = 0 .$$

In practice, this means $\sum Fx = 0$ and $\sum Fy = 0$ (and $\sum Fz = 0$ in 3D).
- **Two-force body:** A two-force body is a rigid part that has forces applied only at two locations. For it to be in static balance, those two forces must be the same size, push in opposite directions, and share one straight line of action (if any other forces or moments exist, it's no longer a simple two-force scenario).
- **Key idea:** In words, "no net force means balance." If you walked away from the FBD and the body didn't move, you implicitly had$\sum F = 0$.

Exam Handbook Search Cues (Not affiliated with or endorsed by NCEES): concurrent forces; resultant of forces; equilibrium; two-force body; sum of forces.

Footnotes (common nuances):

- Forces are vectors (magnitude and direction). Always specify direction or components. Use consistent sign convention (e.g. right/up positive) and be careful with negative signs for opposite directions.

- Units: Force = N (SI) or lbf (US). In USCS problems, remember that weight ($lbm \cdot ft/s^2$) vs force (lbf) can require gc. But if you stay in N or lbf, just use consistency.

- Concurrency assumption: All forces **must** meet at a point; otherwise, moments come into play. If they are not concurrent, you need both $\sum F = 0$and $\sum M = 0$about some point. Here we assume pure concurrent scenario, so the equilibrium check reduces to $\sum F = 0$.

- Hidden assumption: We assume a rigid body and static conditions (no acceleration). Under acceleration, $\sum F = ma$ (with possible gc factor in USCS). For FE statics, use $\sum F = 0$.

Variations, related forms, typical values:

- **Equilibrium in 2D:** Usually expressed component-wise: $\sum Fx = 0$, $\sum Fy = 0$. These give up to two scalar equations for unknowns.

- **Equilibrium in 3D:** Add $\sum Fz = 0$. Now you have three equations; enough if up to three unknown forces. For more unknowns, the system is statically indeterminate (out of scope for concurrent forces only).

- **Resultant magnitude (2 forces):** If two concurrent forces F_1 and F_2 enclose angle θ, you can also use the law of cosines to find the magnitude of R: $R = \sqrt{F_1^2 + F_2^2 + 2F_1F_2\cos\theta}$, and direction by law of sines or component resolution.

- **Three-force body (special case):** If exactly three forces act (still concurrent), equilibrium implies their lines must intersect and the three forces form a closed triangle when added tip-to-tail. There is a unique solution if you know two magnitudes and all directions, or two directions and one magnitude, etc.

- **Typical magnitudes:** Forces are usually tens to thousands of N (or lbf) in structural statics problems. Angles are often nice values (30°, 45°, 60°, etc.) or given by geometry (north of east, etc.). No special numerical "scale" test here, just maintain consistency.

Special notes (calculator tips):

- **Vectors on calculators:** FE calculators have no built-in vector ops. Compute components manually: e.g. for F at angle θ, use Fx=F·cosθ, Fy=F·sinθ.

- **Using law-of-cosines:** On Casio/HP/TI, ensure angle θ is in correct mode (deg vs rad). For example, compute sqrt(F1^2 + F2^2 + 2*F1*F2*cos(θ)). - **Solving equations:** Most problems reduce to linear algebra (sum of components). For Casio fx-115/991 or TI-30X/36X, you can solve linear equations by matrix or direct formulas. On HP (HP-33s/35s), use *RCL* variables or linear solve routine if available. (No special trick beyond routine algebra.)

Equation Passport: Resultant Force (Concurrent System)

Name and purpose: Vector sum of forces – gives the net (resultant) force on a body under a concurrent force system. Use it to check equilibrium or find the single equivalent force.

Equation:

$$\mathbf{R} = \sum_{i=1}^{n} \mathbf{F}_i,$$

with equilibrium condition $\mathbf{R} = \mathbf{0}$ for a static body. In scalar form (2D): $R_x = \sum F_{x,i}$, $R_y = \sum F_{y,i}$.

Variables & units:

- **R**: resultant force vector (units: newtons, N, or pounds force, lbf).
- $\mathbf{F}_i$: i-th applied force vector (N or lbf). Each has components $F_{x,i}, F_{y,i}$ in chosen axes.
- In 3D, also $F_{z,i}$. (Indices $i = 1, \dots, n$.)

Assumptions & scope:

- **Concurrent forces:** All $\mathbf{F}_i$ act at the same point on the body.
- **Rigid body, static:** No motion or acceleration (so ∑F=0 is equilibrium condition).
- **Linear vector addition:** Forces can be added tip-to-tail as vectors.
- *Out of scope:* Distributed loads, force couples (non-concurrent), or any system requiring moments. Those are separate topics.

Limit tests (sanity checks):

- If all forces are zero, then $\mathbf{R} = \mathbf{0}$. If one force increases, **R** grows in that direction.
- If two equal forces in opposite directions act, they cancel: $\mathbf{R} = 0$. If one of them goes to zero, **R** equals the remaining force (you effectively recover a one-force result).
- Angle tests: For two forces of equal magnitude F at 120° apart, $R = F$ (check: they form equilateral triangle).

Use vs. sibling equations: Use this equation instead of a moment-equilibrium formula when **all forces are concurrent**. (If forces are not concurrent or include couples, you must also consider $\sum M = 0$.)

Common exam traps:

- Neglecting direction: Be careful to decompose each force correctly (sign errors in Fx, Fy).
- Unit mix-ups: Don't mix N and lbf or forget *gc* when mixing SI and USCS units.
- Forgetting concurrency: If forces don't actually meet, $\sum F = 0$alone is not sufficient (you'd miss a net moment). The problem will usually specify or show a common intersection for "concurrent" cases.
- 2-force body mistake: Don't assume two forces always balance; if their lines of action don't align, the object cannot be in equilibrium unless a moment exists (contradicting "two-force only").

Explanation & Analysis:

This formula is fundamental: it says the net force on the body is just the head-to-tail vector sum of all applied forces. In FE problems, you apply it by resolving forces into components or by using vector geometry. You often start by **sketching a Free-Body Diagram (FBD)** at the joint or point of intersection. Label each force $\mathbf{F}_1, \mathbf{F}_2, \dots$ with its magnitude and angle or direction. Then write component equations:

- $\sum F_x = F_{x,1} + F_{x,2} + \cdots = 0,$
- $\sum F_y = F_{y,1} + F_{y,2} + \cdots = 0.$

(If there's a third dimension, add $\sum F_z = 0$ similarly.) Each $F_{x,i} = F_i \cos\theta_i$ and $F_{y,i} = F_i \sin\theta_i$ (or via vector direction cosines). Solving these equations yields any unknown force magnitudes or angles. If all these sums truly zero out (within sign conventions), the system is in equilibrium – there is no "leftover" force trying to move the body.

Term breakdown: In $\mathbf{R} = \sum \mathbf{F}_i$, each $\mathbf{F}_i$ is a force vector (units N or lbf). Commonly, we use subscripts or index i to label different forces (e.g. F_1, F_2). The vector arrow denotes that direction matters; $\mathbf{R}$ is also a vector. If you compute $\mathbf{R} = \mathbf{0}$, it means $R_x = 0$ and $R_y = 0$, not just that the magnitudes sum to zero. Always keep track of axis directions. Units for $\mathbf{R}$ are the same as for each $\mathbf{F}_i$.

Pitfalls: A very common mistake is forgetting that forces subtract when pointing in opposite directions. For example, if one force is leftward (negative x) and another is rightward (positive x), $R_x = (+F) + (-F)$ will cancel. Another pitfall is using scalar magnitudes without vector resolution (leading to wrong results when forces aren't collinear).

Quick self-check: A handy mental test is: *"If I put my finger on the pin, will it move?"* If yes, $\sum F \neq 0$. Also, if two forces in equilibrium have only two arrows, imagine placing them tip-to-tail; they must exactly close a loop. If they don't, something's off.

Topic 03 - Equilibrium of Rigid Bodies

Topic Introduction: In the statics domain of the FE Mechanical Exam, **equilibrium of rigid bodies** is a foundational topic. It deals with conditions under which a structure or machine remains at rest (no linear or rotational acceleration). Practically, this means all forces and moments balance out. On exam day, you'll encounter problems asking for support reactions on beams, forces in pinned structures, or whether a body will tip or stay put. Mastering this topic equips you to set up **∑F = 0** and **∑M = 0** equations confidently for any rigid body scenario – a skill that underpins almost every statics question.

Typical question archetypes include: finding the reaction forces at supports of a loaded beam, determining forces in links or pins of a frame, or checking if an object under multiple forces is in equilibrium. The key is always the same: draw a clear free-body diagram, write out the equilibrium equations, and solve for the unknowns. This chapter will guide you through the core principles (and pitfalls) of doing just that, aligned with the FE Mechanical exam requirements.

K06.T03.S01 – Conditions for Rigid-Body Equilibrium in a Plane

Principle Introduction – Subtopic Background: In order for a rigid body to remain static (not accelerate or rotate), it must satisfy certain force and moment balance conditions. In a two-dimensional (planar) setting, those conditions distill to three independent equations:

- **No net force in the x-direction:** All horizontal forces must cancel out.
- **No net force in the y-direction:** All vertical forces must cancel out.
- **No net moment about the z-axis (out-of-plane):** The total clockwise moment about any point must equal the total counterclockwise moment about that point.

These **equations of equilibrium** are the backbone of statics. They allow engineers to solve for unknown forces (like support reactions or cable tensions) acting on a structure. A typical FE exam problem will give a rigid body with loads and supports; using these equations, you'll find the support forces or check if a design is stable. It's essential to include *all* external forces (weights, loads, support reactions, etc.) in the summations and maintain a consistent sign convention. Below is the formal "passport" for planar equilibrium equations, summarizing their usage and key points:

Equations of Equilibrium (2D) – *ensure zero net force and zero net moment for a stationary rigid body in a plane.*

Formal Equations:

$$\sum F_x = 0, \qquad \sum F_y = 0, \qquad \sum M_z = 0,$$

where the x and y axes lie in the plane of the rigid body, and M_z is the moment about an axis perpendicular to that plane.

Variables and Units:

– $\sum F_x$: Sum of all force components along the x-axis (unit: N in SI or lbf in USCS).
– $\sum F_y$: Sum of all force components along the y-axis (N or lbf).
– $\sum M_z$: Sum of moments about the z-axis (unit: N·m or lbf·ft). Conventionally, take counterclockwise moments as positive M_z (you can choose clockwise positive instead—just stay consistent). Moments can be computed about any convenient reference point in the plane; for equilibrium, the sum will be zero about *every* point if the body is truly in static balance.

Assumptions and Scope:

– The body is **rigid** (no deformation) and remains **stationary** (no linear or angular acceleration). This is essentially an application of Newton's 1st law (static case).

– All forces lie in a single plane (2D problem). Out-of-plane forces/moments are not present, so we only have three equilibrium equations. (For a general 3D case, there would be six equations: $\sum F_x = \sum F_y = \sum F_z = 0$ and $\sum M_x = \sum M_y = \sum M_z = 0$. Most FE Mechanical problems are planar, so 3D equilibrium is rarely tested beyond conceptual understanding.)

– We assume a **consistent coordinate system**. You will typically define $+x$ to the right and $+y$ upward (or another convenient orientation) and stick to it. Likewise, define a positive moment direction (often counterclockwise) and use it uniformly.

Limit Checks (Sanity Tests):

– If any one of these summations is not zero, the object would experience acceleration (translation or rotation), violating the static assumption. For example, if $\sum F_x = +100$ N instead of 0, that implies an unbalanced 100 N pushing the object in +x direction, and it would **not** remain at rest. Thus, on the exam, if you find a nonzero sum, it's a red flag; either the body isn't in equilibrium or (more likely) there's an error in your calculations or free-body diagram.

– **Quick directional check:** Imagine increasing one of the forces on the diagram gradually. If the sums are truly zero, a small increase in, say, a rightward force will make $\sum F_x$ nonzero (positive), meaning the body would start accelerating rightward. In a correct equilibrium setup, any small imbalance should immediately stand out by making one of your equations $\neq 0$. Use this idea to double-check: remove or zero-out one force in your mind; you should predict which way the body would move if that force weren't there. If you can't easily tell, re-inspect the FBD for completeness.

Use vs. Sibling Equations:

– Use **these 3 planar equilibrium equations** for any rigid-body statics problem in two dimensions. They are the default tool for beams, frames, machines, and any components confined to a plane.

– In contrast, **particle equilibrium** (from earlier physics, where you had only $\sum F_x = 0, \sum F_y = 0$ for a point mass) doesn't include moments. Here we deal with extended bodies that can also rotate, so the moment equation $\sum M_z = 0$ is crucial.

– Don't confuse these with **dynamics equations** (like $F = ma$ or $M = I\alpha$): in statics, acceleration a and α are zero, so $F = 0$ and $M = 0$. Essentially, we've set $ma = 0$ to get $\sum F = 0$. Thus, if you ever accidentally set $\sum F = ma$ on a static problem in the FE exam, you're doing extra work – remember $a = 0$! (That said, if a problem ever hints that something is on the verge of moving, like impending motion in friction problems, you still use $\sum F = 0$ but with friction at its maximum value, etc.)

Common Exam Traps:

– **Omitting forces:** A very frequent mistake is to leave out a force when writing $\sum F_x = 0$ or $\sum F_y = 0$. For example, forgetting the weight of the structure (if not given explicitly, you might assume it's negligible – but if dimensions/material are given, the exam may expect you to include weight). Always double-check the free-body diagram: every force on the diagram must appear in your equilibrium equations. Conversely, every force in the equations should be drawn on the FBD. Missing or extra forces cause an imbalance.

– **Sign convention errors:** Define a positive direction for each axis and stick to it. If you take upward forces as positive in $\sum F_y$, then a downward force (like weight) enters the equation with a negative sign. It's easy under time pressure to, say, plug 50 N for a weight force when it should be -50 N (if up is +). Writing a small $\uparrow^+$ or $\rightarrow^+$ on your FBD near the axes can remind you. Similarly for moments, if you assume counterclockwise (↺) as positive, then a clockwise moment contribution is negative. A consistent sign convention is the difference between a correct solve and chasing errors.

– **Using the wrong moment center:** You can sum moments about *any* point for a rigid body in equilibrium, and it will be zero. The **savvy move** is to choose the point that simplifies the math. A classic strategy is to sum moments about a support that has multiple unknown forces (since a force acting at that point produces zero moment about itself). This eliminates those unknowns from the moment equation, letting you solve for another unknown directly. A trap is forgetting this and writing $\sum M$ about, say, the centroid or some arbitrary point, and then struggling with an equation containing too many unknowns. Always consider: "Where should I take moments so that I knock out the most unknowns at once?" On the exam, a good choice of pivot can save you precious time and reduce algebra mistakes.

– **Mismatched units:** Ensure all forces are in the same unit system when summing. Mixing kips with pounds or N with kN without converting will give nonsense results. Likewise, moment units must be consistent (force × distance). If you use SI, stick to N and m (so moments in N·m). In USCS, you might use lbf and ft (giving lbf·ft) – just be cautious if inches creep in, convert them to feet for the moment arm or force as needed.

– **Forgetting 2D scope:** Sometimes students worry about out-of-plane forces or moments that don't exist in the problem. For a flat 2D problem (like a planar truss or a beam in the page), you don't have to consider $\sum F_z$ or $\sum M_x$ etc. All action is in plane. If a problem does have a force that's not in the main plane (say, a bracket with a force coming out of the page), then it's not a pure 2D statics scenario; the exam would likely clarify how to handle it, or it's in the context of something like friction or tipping which still can be handled in planar equilibrium with an added consideration. In short: don't invent extra equilibrium equations that aren't applicable; stick to the three for planar cases.

Exam Handbook Search Cues (Not affiliated with or endorsed by NCEES): *equilibrium, equilibrium requirements, force balance, moment balance, static equilibrium equations* (These are keywords you'd use to find related equations or definitions in the exam reference handbook. For example, searching "equilibrium" or "∑F" in the handbook PDF will bring up the equilibrium conditions section. The handbook provides the formula statements $\Sigma F_n = 0$ and $\Sigma M_n = 0$, but it's up to you to know how to apply them.)

Footnotes:

- *Sign Convention Tip:* If you accidentally sum forces with inconsistent sign assumptions (e.g. mixing up which direction is positive between equations), the equations you solve will be mathematically inconsistent. A quick fix if you're unsure: stick a coordinate axis symbol on your FBD (draw a little x-y arrow in the corner). That visual cue can prevent sign mistakes under pressure.

- *Moments About Any Point:* Remember, if $\sum \vec{F} = 0$ for a rigid body, then $\sum \vec{M}$ is zero about *any* point. If you get $\sum M_A = 0$ and $\sum M_B = 0$ as separate equations about two different points A and B, they are not independent; they contain essentially the same info combined with the force equilibrium results. The exam won't make you write moments about multiple points unless you're solving piecewise for different bodies. One point is enough to capture the rotational equilibrium, so choose it wisely.

- *2D vs 3D:* On the FE Mechanical, most statics problems are 2D. If a 3D equilibrium problem appears, it will likely be conceptual or simplified (e.g. asking how many equilibrium equations can be written, or a trivial case). Don't panic—apply the same logic: all forces and all moments must sum to zero in each independent direction. You won't be asked to invert a 6×6 matrix or anything crazy; usually, it's a determinate structure that can be solved with a couple of clever moment and force equations.

Variations and Related Forms:

- **Two-Force Members:** A special (and common) case of equilibrium is a **two-force body**. This is a rigid body with only two forces acting on it (and no moments, typically the body is a link pin-connected at both ends). For it to satisfy $\sum F_x = 0, \sum F_y = 0, \sum M_z = 0$, those two forces must be **collinear, opposite in direction and equal in magnitude** (acting along the same line). Essentially, it becomes a straight internal tension or compression member. This often appears in trusses or frames: if you identify a member that only connects at two pin joints and has no load in between, you know immediately that the force at one end equals the force at the other, along the line of the member. That can save time by reducing unknowns. (On the exam, they might not explicitly ask "is this a two-force member?" but if you recognize one, you can simplify your FBDs significantly by replacing that member with a single force of unknown magnitude along its axis.)
- **Three-Force Members:** Similarly, if exactly three forces act on a rigid body in equilibrium (with no couple moments), either those forces must intersect at a common point (concurrent) or be parallel. Otherwise, it's impossible to satisfy equilibrium – an important insight for complex systems. While you likely won't be asked for the theory of it, this knowledge can be a quick check: if you have a body with three forces and you draw their

lines of action, they should meet at a point if the body is in equilibrium. If not, re-check the problem setup.

- **Static Determinacy:** The number of independent equilibrium equations available (three in 2D) also tells you the maximum number of unknown support reactions you can solve for. A structure is **statically determinate** if the count of unknown reaction forces/moments is equal to the number of available equilibrium equations (and the equations are indeed independent). If supports introduce more unknowns than equations, the structure is **statically indeterminate** (you would need additional deflection or material equations to solve it, which is beyond the scope of pure statics and typically beyond the FE exam aside from a conceptual question). For example, a simple beam with a pin and a roller is determinate (3 unknowns: two forces at the pin, one at the roller, matching the 3 equations). But a beam with two fixed ends has 4 unknown reactions (2 forces + 2 moments), making it indeterminate to the first degree. The FE exam might present a support scenario and ask if it's determinate; your quick rule-of-thumb is to count reactions vs. 3. Keep this in mind when setting up equations – if you see 4 unknowns and only 3 equations, either there's an additional relationship (like symmetry or equal distribution) given, or it's not solvable with statics alone.

K06.T03.S02 – Free-Body Diagrams and Static Equilibrium for Structures and Machines

Principle Introduction – Subtopic Background: When tackling any equilibrium problem – whether it's a simple beam or a complex machine – the **free-body diagram (FBD)** is your best friend. This diagram strips away all the supports and adjacent structures, isolating the object of interest and showing *every* force and couple acting on it. For complex structures or machines composed of multiple connected parts, you often draw multiple FBDs (one for each part or a strategic portion) to analyze the forces at the connections. Key ideas include:

Isolate the body: Mentally "cut loose" the structure or component from its supports and other bodies. Replace each support with its reaction forces/moments, and each connection with the forces it exerts (if another part was attached, that attachment force is now an external force on your FBD).

Show all forces and moments: This means gravity (weights), applied loads, support reactions, and even forces between separated parts. Nothing mystic or hidden – if it's pushing or pulling on the body, draw it as an arrow. If a support prevents rotation (fixed support), include an arrowed couple (moment). If a pin connected to another member is cut, include the force that pin applies (often an unknown in two perpendicular components). A well-drawn FBD has all the "givens" and unknowns clearly represented.

Use clear notation: Label each force with a symbol (e.g., F_{AB} for force from member AB, or A_x, A_y for support reactions at support A). Indicate dimensions or angles on the diagram as needed for finding moments or resolving forces. The goal is that someone else could look at your FBD and write the equilibrium equations from it without additional explanation.

Frames and machines strategy: For structures with multiple connected rigid bodies (like a pin-jointed frame or a simple machine with links), draw FBDs for each **separate piece**. Each pin or contact force will appear on two diagrams (equal and opposite on each part, per Newton's Third Law). This approach lets you solve internal forces in the connections. For example, if two members are pinned together, you isolate each and put an unknown force P on each FBD at that pin (opposite directions on each diagram). Then, those forces will be solved by applying equilibrium to each member.

Equilibrium applies to each FBD: Once the diagram is drawn, apply $\sum F_x = 0, \sum F_y = 0, \sum M = 0$ to that free body. This yields equations you can solve for the unknown forces. In a complex assembly, you may have more unknowns than equations on a single FBD – that's normal. You'll write equilibrium equations for another part (or the whole assembly) which provide the additional equations needed. The art is sometimes deciding which body's FBD will give the cleanest equation for a particular unknown. This comes with practice – but the FE problems are usually set up so there's an obvious way to go step by step.

In short, mastering FBDs is **critical**. As an instructor, I often tell students: *"If you can draw all the forces correctly, you've solved more than half the problem."* Let's formalize the concept with a definition passport for the free-body diagram:

Definition: Free-Body Diagram (FBD) – a simplified sketch of a detached object or system **free of its supports and surroundings**, showing all external forces and moments acting on it. Each force is represented by an arrow pointing in the direction the force is applied on the body, with its label (magnitude known or unknown). Moments (couples) are shown as curved arrows. The FBD does *not* show internal forces *within* the object; it only shows interactions with the environment (including gravity). Essentially, it's the bookkeeping diagram that ensures you account for every push and pull before writing equilibrium equations.

Where it matters (exam impact): Virtually every statics question on the FE Mechanical Exam involves or benefits from drawing a correct FBD. For instance, if a problem gives you a complex frame with loads at various points, the recommended first step is to sketch the frame and mark all forces on each section of it. The exam might not explicitly say "draw a free-body diagram," but doing so will make applying equilibrium much easier and less error-prone. In some cases, the exam may present you with a diagram and you must identify forces or fill in missing reactions – effectively interpreting or completing an FBD. If you ever feel stuck setting up equations, chances are something is missing or unclear on your free-body diagram. It's your go-to tool for clarity.

Common pitfall or confusion: The biggest mistake is **omitting a force**. For example, you might forget the reaction at a support, or forget that a hanging beam has weight, or miss that a pin connected to another member will exert forces in two directions. Every contact point is a force. Another pitfall is **adding nonexistent forces**: sometimes students add a horizontal reaction at a roller (where none exists), or add two separate forces when there should be just one resultant. Also beware of mixing up forces – e.g., confusing a normal force with a frictional force direction on an incline, or labeling the weight mg as if it's a separate push. Each force on an FBD should have a clear physical source. If you can't explain what a force represents in reality, it probably doesn't belong on the diagram. Finally, ensure your force directions are sensible: if you assume a reaction force upward but the actual reaction could be downward (if, say, there's a downward support or a suction force), that's okay – you'll get a negative value when solving. But do **assume a direction for every unknown** (even if it might be wrong). A missing arrow is worse than one drawn the

wrong way (the math will correct a wrong assumption with a minus sign; it can't solve a force that isn't in the equations at all).

Micro-check: True or False? – "Every force drawn on a free-body diagram comes from something external to that body (another object, support, or field like gravity), and for every contact force the equal-and-opposite force appears on some other body's FBD." **True.** (If you find a force on your diagram that you can't identify a source for, that's a red flag. And if you separated two connected bodies, make sure you've added equal-opposite forces on each side of the separation.) Another quick check: count the forces on your FBD and match them to physical entities: e.g., "I have 1 weight, 2 support reactions, and a 10 kN applied load – that's four forces total, which correspond to: gravity, pin support (x and y), and the applied load." This sanity check ensures you haven't missed or invented forces.

Now, how do we *use* FBDs along with equilibrium equations in practice? Let's go through explanation and analysis:

Explanation & Analysis (Step-by-Step Application): Drawing the FBD is Step 1 in solving any statics problem:

1. **Sketch the structure and "cut" it out from its environment.** For example, imagine a simple **crane**: a beam pinned to a wall at the base and held by a cable at the top. To find forces in the pin and cable, first sketch the beam by itself. At the pin connection (wall base), remove the wall and instead draw the pin's reaction forces on the beam: typically an unknown horizontal force A_x, an unknown vertical force A_y (because a pin can support forces in two directions). At the cable attachment, remove the cable and replace it with the tension force T pulling on the beam (along the cable's direction). Include the beam's weight (if given or needed) as a force downward at its center of gravity, and any external loads (say a weight hanging from the boom). Now you have the beam "free" with all forces on it – that's your FBD.

2. **Apply equilibrium equations to the FBD:** With the beam example, you'd write $\sum F_x = 0$ (taking, say, rightward as positive) which might give $A_x - T\cos\theta = 0$ if $T\cos\theta$ is the horizontal pull of the cable. Then $\sum F_y = 0$ (upward positive) could give $A_y + T\sin\theta - W_{\text{beam}} - W_{\text{load}} = 0$ (support's upward force plus cable's upward component balances the weights). And $\sum M_z = 0$ about the pin (point A) can let you solve T by taking moments of the weights and the cable tension about A. By choosing point A, A_x and A_y create no moment (since their line of action goes through A), which is why it's smart to sum moments about the pin support in this case – it eliminates two unknowns in one equation. This leaves an equation involving T and known distances and weights that you can solve quickly. Once T is found, plug back into the force equations to get A_x, A_y.

3. **Handling multiple bodies (machines or frames):** If the structure has multiple connected parts, decide whether to draw FBDs of each part or perhaps the whole assembly first. For a **machine** (an assembly with pins and perhaps sliders), it's often useful to draw an FBD of the entire assembly to find external reactions, then draw FBDs of individual components to find forces in the pins. For example, consider a simple **pin-connected two-member frame** with an external load at the joint. You could draw the whole frame as one FBD to find the support reactions at the base supports. Then, to find the internal force in the pin joint or within each member, draw FBDs of each member separated at the pin. At the pin connection, if one member has a force P to the right on it, the other member's FBD gets a force P to the left (equal and opposite). Write equilibrium for each member to solve those internal forces. The key is consistency: when you "cut" a pin, assign one member's pin force arrow arbitrarily (say P pointing toward the pin on member 1). On member 2's FBD, put P pointing the opposite way. This ensures the sum of forces for the combined system would cancel at that pin (which it must, since the pin is internal). Solving the equations for each FBD will yield the value of P (and sign will tell you direction relative to your assumption, as usual).

4. **Interpret the results back on the real structure:** Once you solve the equations, you'll have numbers for reactions and internal forces. Always take a moment to map these back: is the pin reaction upward, meaning the support is pushing up on the structure (which is expected if there was weight)? Is the horizontal reaction pulling left on the structure, meaning the structure pushes right on the support (action-reaction)? Does the magnitude seem reasonable (no insanely large force if only a small load was applied)? Checking results with a physical intuition can catch errors. For instance, if you get a negative value for a force you assumed up, it just means the actual force is down – that's fine, just interpret it correctly: maybe the support is actually in tension pulling down on the body instead of pushing up. Negative answers are common and just indicate the opposite direction of what you drew. They are not "wrong" if the magnitude is right; it's your initial guess of direction that was off, which is okay.

5. **Practice and pattern recognition:** Through practice, you'll recognize common FBD patterns: a simply supported beam always has an upward reaction at the supports to hold the weight; a hanging sign on a cable always has cable tension equal to the weight if it's static (and the wall sees that force too); a symmetric load yields symmetric reactions, etc. Use these insights as cross-checks. The FE exam often features problems that can be simplified by symmetry or by recognizing a member is a two-force member (as discussed earlier). For example, if a symmetrical structure has identical supports and a centered load, you can argue the reactions must be equal by symmetry *before* doing math, then just solve one equation for those equal reactions.

Exam Handbook Search Cues (Not affiliated with or endorsed by NCEES): *free-body diagram, free body, equilibrium analysis, frames and machines, method of sections, method of joints* (While the exam reference handbook may not explicitly teach you how to draw FBDs, it does mention terms like "free-body diagrams" in the context of truss methods. Searching these keywords could lead you to example diagrams or remind you of the process. Ultimately, the skill of drawing FBDs comes from practice – so use the handbook as a reference for equilibrium principles, but rely on your own systematic approach to sketching forces.)

Footnotes:

- *Weight vs. Mass on FBD:* Remember that weight W is a force. If a problem gives mass (say in kg), you need to multiply by $g \approx 9.81$ m/s^2 to get the weight in newtons for your FBD. In US units, if given weight in lbf you can use it directly as a force. It's easy to accidentally put "10 kg" as a force in an equation – that's a mass, not a force! Convert it to $W = mg \approx 98$ N. The exam might include both mass and force units, so keep an eye on that. If using USCS units, also be cautious: 1 slug mass has a weight of 32.174 lbf (on Earth). Usually, FE problems avoid slug calculations, but just know weight (lbf) = mass (lbm) × 32.174 ft/s² / g_c.

- *Internal forces vs. external:* The FBD should not explicitly show internal forces within a member (like the tension within a rope as an internal stress – unless you cut the rope). Only show forces where you made "cuts" isolating the body. For example, if analyzing a beam with a weight hanging in the middle, you don't draw the internal shear force at the cut – you draw the weight and the support reactions. If you then cut the beam at mid-span to find internal shear/moment at that cut, that's a new FBD of one half of the beam, and the internal force becomes an external one on that new FBD. This way, internal forces are always revealed by making an imaginary cut and considering equilibrium of one side of the cut. This is the principle behind shear and moment diagrams, or method of sections in trusses.

- *Solving multiple bodies:* In frame/machine problems, plan ahead: count total unknowns and available equations (3 per rigid body FBD). If you have two bodies, you have 6 equations in total. If there are, say, 5 unknown forces across the system, you're in good shape (you can solve it all). If there are 7 unknowns, something's off – either it's indeterminate or you need another equation (maybe a symmetry condition or static friction limiting condition, etc.). The exam usually gives determinate setups. It's also worth noting: if two bodies are bolted or welded (fixed) together, you treat them as one combined body for FBD purposes (because they don't have an internal hinge that gives separate equilibrium conditions). Only "separate" at points that are pins or contact that allow relative motion. This can help reduce the problem: sometimes taking the whole assembly as one FBD first is simplest for external reactions.

- *Units on sketches:* It's good practice to jot down lengths, angles, and forces on your FBD with units (e.g., mark a length as 3 m, force as 5 kN). Keeping track of units visually can prevent mixing incompatible units in equations. It also makes it easier to plug into the calculator correctly. The exam handbook provides many constants and conversion factors, but labeling your diagram with given values in a consistent unit set (all SI or all USCS) will speed you up.

Variations and Related Strategies:

Method of Joints (Trusses): Although truss analysis (method of joints and sections) formally belongs to the "internal forces in rigid bodies" topic, it's essentially an application of FBDs and equilibrium. Each truss joint is drawn as a tiny FBD with forces from connected members. The method of joints says: isolate a pin joint (small FBD) → apply $\sum F_x = 0, \sum F_y = 0$ (no moment eq because the joint is a point) → solve for member forces. The trick is often picking the right joint (one with at most 2 unknowns to solve easily). This is a direct extension of what you've learned: the joint is the free body, the member forces are just forces on it. The FE exam may have you do one or two joints to find a particular member force. The key is still drawing the FBD carefully (show each member force either pulling away from the joint (tension assumption) or pushing toward it (compression assumption), and any external loads at that joint). Then solve the equilibrium equations.

Symmetry and Redundancy: As mentioned, if a structure is symmetric and loads are symmetric, you can simplify your FBD by just drawing half (with appropriate boundary conditions) or by reasoning that certain forces are equal. E.g., two equal supports under a symmetric beam will share the load equally. While you should still confirm with equilibrium equations, recognizing this can speed up your work. Another scenario: if a support is not actually needed for equilibrium (redundant), sometimes you can identify it by imagining removing it – if the structure would still be held by other supports, that reaction might be zero. For instance, a three-support beam (with two obvious supports and one extra lightly touching somewhere) might have the extra support carry no load unless the beam sags to contact it. Such nuances are rare in exam questions, but basic reasoning about "does this force really act?" can sometimes simplify an FBD (you might initially draw a force at a contact point, then realize there's no actual contact force if the geometry doesn't enforce it).

Inclined surfaces or supports: If a body is on an incline or has a roller on a slope, adapt the FBD. It can be convenient to tilt your axes so one axis is along the incline. The normal force then is perpendicular to that surface (along one axis), and friction (if any) is along the surface (along the other axis). The equilibrium conditions still apply, just in your rotated coordinate system. The exam might give an inclined roller or a link at some angle – break the forces into components along convenient directions (usually horizontal/vertical unless the entire problem is easier rotated). The FBD should reflect that: draw the normal force perpendicular to the surface (with an unknown magnitude), and if friction is present, a force parallel to the surface. This is another area students slip: forgetting to resolve weight into components parallel/perpendicular to an incline. Always draw weight vertically downwards, then if working on incline axes, show it as $W\cos\alpha$ and $W\sin\alpha$ components on the diagram (with α being the incline angle). Mark angles so you don't mix up sine and cosine. A well-annotated FBD with components will virtually hand you the correct equilibrium equations.

K06.T03.S03 – Support Reactions for Various Supports (Pins, Rollers, Fixed)

Principle Introduction – Subtopic Background: When a structure is supported in different ways, those supports "react" against loads by exerting forces (and possibly moments) on the structure. Identifying the correct **support reactions** is crucial for writing equilibrium equations. Each support type – whether a simple pin, a roller, or a fixed clamp – has a characteristic set of reaction forces and/or moments it can provide. In exam problems, you are often given a diagram with supports indicated by symbols (like a triangle for a pin or roller, or a wall for fixed). It's your job to recall what forces or moments each of those supports can exert. This subtopic ties closely to static determinacy: the number and type of support reactions must align with the equilibrium equations. Here's a rundown of common supports in 2D and their reactions:

Pin (Hinge) Support: A pin support restrains the structure from moving in two perpendicular directions (usually horizontal and vertical), but it does *not* restrain rotation. So it can exert a force in the x-direction and a force in the y-direction on the body (often denoted A_x, A_y if the support is at point A, for example). It cannot exert a moment – the structure is free to rotate about the pin. Think

of a door hinge: it can hold the door from falling down or moving sideways, but it won't stop the door from swinging. On an FBD, a pin is represented by two reaction force components (usually drawn as one horizontal arrow and one vertical arrow at that support). If you don't know the directions of the reactions beforehand, you assume a direction (typically assume positive directions like up and right) and solve – a negative result means the force actually goes opposite.

Roller Support: A roller allows a structure to expand/contract or move freely in one direction (usually horizontally) while preventing movement in the perpendicular direction (vertically, if it's a roller on horizontal ground). It also does not restrain rotation. So a roller provides **one** force reaction, typically an upward force if the roller is on a horizontal surface (the normal force from the ground). It cannot provide any horizontal force (it rolls, so no friction in the idealized sense) and no moment resistance. A visual example is a heavy beam resting on a small wheel: the wheel pushes up on the beam but can't grab it sideways or stop it from rotating a bit. On FBDs, a roller is shown with a single force arrow – usually B_y upward if the roller is at point B, for instance. If the roller is on an incline, the reaction is perpendicular to that surface (still one force, just not vertical/horizontal in that case). The main point is **one reaction force, no moment.**

Fixed Support: A fixed support (also called encastre or built-in end, like a beam rigidly embedded in a wall) restrains **both translation and rotation**. That means it can exert force in the x-direction, force in the y-direction, **and** a moment. In other words, it provides up to three reactions (in 2D): R_x, R_y, and M_z. The wall can push/pull horizontally, push up/down vertically, and twist on the beam to hold it in place. If you see a cantilever beam jutting out of a wall, that wall is a fixed support: it will have a bending moment reaction in addition to shear and possibly axial force. On an FBD, a fixed support is represented by two force components (horizontal and vertical) and a curved arrow to denote the moment. If not given labels, you might call them C_x, C_y and M_C for a fixed support at point C, for example. One common scenario: a cantilever beam carrying a load P at its end will have a reaction moment at the wall equal to $P \times$ (beam length), and an upward reaction force equal to P, and often no horizontal force if P was vertical. Recognizing that at a fixed support you have a moment reaction is crucial (students sometimes forget to include it on the FBD, which then makes equilibrium impossible to satisfy).

From the figure and descriptions, we can tabulate the support reaction components for clarity:

Support Type	Reaction Components (in plane)	Allows/Restrains
Pin (Hinge)	Forces: R_x, R_y (horizontal and vertical). No moment.	**Restrains** translation in x and y (structure can't move sideways or up/down at this support). **Allows** rotation (the joint is free to rotate).
Roller	Force: $R_\perp$ (one force, normal to the surface). No R parallel to surface, no moment.	**Restrains** motion perpendicular to surface (e.g., no vertical movement if on horizontal ground). **Allows** movement along the surface and rotation. (Ideal roller has no friction, hence no parallel force).
Fixed	Forces: R_x, R_y; Moment: M_z.	**Restrains** all movement: no translation in x or y, and no rotation at the support (fully rigid connection).

Understanding these distinctions guides how you set up your equilibrium equations: for a pin support, you will typically have two reaction unknowns to solve for; for a roller, just one; for a fixed support, three (though sometimes geometry or loading results in one being zero – e.g., no horizontal force if no horizontal load).

Exam Tip: count your support reactions and make sure the total number of unknowns does not exceed the number of independent equilibrium equations (usually 3 for a single rigid body). For example, a beam with a pin support at one end (2 unknowns) and a roller at the other (1 unknown) has 3 unknowns total – nicely matching the 3 equations, so it's solvable (statically determinate). A beam with two pin supports (2+2=4 unknowns) would be **statically indeterminate** by one degree (4 unknowns vs 3 equations) – the exam might test if you recognize that, though usually they stick to determinate cases for actual computation. If you encounter an apparently indeterminate setup in a problem, double-check if you interpreted the supports correctly (maybe one of the supports is actually a roller and only provides one force, etc.). Often, one support might not be fully preventing motion in both directions, reducing the unknown count.

Common Pitfalls with Supports:

- *Forgetting a reaction component:* If a support can resist force in both x and y, you need to include both in your equations (even if one later turns out to be zero due to how loading is distributed). Students sometimes only put, say, a vertical reaction for a pin and neglect the horizontal one – which might be fine if indeed no horizontal loads exist, but if there is any angled force or asymmetry, there will be a horizontal reaction. Always ask: can this support resist horizontal motion? If yes, include R_x. The exam might, for instance, have a beam with an angled load – the pin will have to react in horizontal direction too, not just vertical.

- *Adding a reaction that doesn't exist:* The opposite error is adding an extra reaction where it shouldn't be. A classic example: adding a horizontal reaction at a roller support on flat ground. A roller can roll freely, so it cannot support horizontal force – there should be no R_x at that support. If you put one in your equations, you've introduced a false unknown and you'll get stuck (or the math will force it to zero anyway). Similarly, you cannot have a moment reaction at a pin or roller – don't include one. If a problem statement says "pin support" or uses the pin symbol, that means no moment reaction.

- *Incorrectly modeling a support's angle:* If a support is not oriented horizontally/vertically (imagine a roller on a sloped surface, or a hinge that slides in a slot), you must resolve what directions it actually restricts. For a roller on a 30° incline, for instance, the reaction force will be perpendicular to that incline. You could break that into x and y components when writing equations, but fundamentally there's just one reaction force along that normal. If you try to assume a vertical reaction out of habit, you'll be off. The exam usually provides enough info (like showing the roller on an incline explicitly). Just remember: **normal force is normal to the surface**. One approach is to rotate your reference frame to align with the incline for that body's FBD. Or resolve the normal reaction into horizontal/vertical components carefully using the given angle.

- *Forgetting weight of supports:* Generally, support structures (like the ground or wall) are not part of your free body, so you don't include their weight or anything. But sometimes a support might itself have weight if it's part of the system (like a rolling support that's actually a small cart attached to the structure). Usually not the case in FE problems – they treat supports as immovable objects. So focus on forces *on* the structure by the support, not anything else.

- *Fixed support reaction sign conventions:* When you solve for a moment at a fixed support, a positive value might mean a **counterclockwise** moment reaction (if you assumed counterclockwise as positive in your equation). Students sometimes get confused interpreting the sign – e.g., you find $M_A = -50$ kN·m. If you assumed counterclockwise positive, this means the actual reaction moment at the support is 50 kN·m clockwise. On a diagram, you'd draw a curved arrow indicating that sense. The exam might just ask for magnitude (50 kN·m) which is fine, but if a conceptual question asks "is the moment clockwise or counterclockwise on the support," you need to interpret the sign with your convention. It helps to jot a small note on your FBD: like "assume M_A as drawn is clockwise". Then if you solve and get negative, you'll quickly realize it's opposite of your assumption.

Explanation & Analysis: Let's put these support reaction concepts into use with a brief analysis example and tie it to equilibrium equations:

Imagine a simply supported beam (a classic case) – a horizontal beam with a pin support at the left end (A) and a roller support at the right end (B). Say the beam has a length L and a downward point load P in the middle. What are the support reactions?

1. **Identify support types and unknowns:** At A (pin), we have two reaction forces: let's call them A_y upward and A_x to the right (assuming positive up/right). At B (roller), we have one reaction, B_y upward (since the roller only provides a vertical force). There's no B_x and no moments at either support. So, we have 3 unknowns: A_x, A_y, B_y.

2. **Apply equilibrium:** Start with horizontal forces: $\sum F_x = 0$. The only possible horizontal forces are A_x and perhaps components of any angled loads. Here P is vertical, and presumably no other horizontal loads, so $\sum F_x = A_x + (0) = 0$. Thus, $A_x = 0$. This makes sense: there's no horizontal push on the beam, so the pin isn't pulling or pushing (and the roller couldn't anyway). Many simply supported beams end up with zero horizontal reaction unless there's an incline or other horizontal force. Great, one unknown down.

3. Next, vertical forces: $\sum F_y = 0$. Taking up as positive: $A_y + B_y - P = 0$. Here, P is the downward load (we plug it as negative in the sum since it's downward). So $A_y + B_y = P$. This tells us together the supports carry the total load P. We can't solve A_y and B_y individually from this alone – one equation, two unknowns – so we move to the moment equation.

4. Take moments about one of the supports (the clever choice). Usually, you pick one support to eliminate its forces. If we sum moments about A (left end) and take counterclockwise as positive, the contributions would be: A_y and A_x go through point A (distance zero), so they don't appear. B_y produces a moment about A: it's upward, located at the right end a distance L away, tending to rotate the beam counterclockwise around A (imagine pushing up on the right end, the beam would rotate CCW around A) – so $B_y \times L$ is a positive moment. The load P at midspan produces a moment about A: it's downward, at distance $L/2$, which would rotate the beam clockwise around A (pushing down in the middle makes the left end want to go up, that's CW rotation) – so that moment is $-P \times (L/2)$ in the sum (negative because clockwise). Setting $\sum M_A = 0$:

   $B_y \cdot L - P \cdot \frac{L}{2} = 0$.

   Solve for B_y: $B_y \cdot L = \frac{PL}{2}$ so $B_y = \frac{P}{2}$. Plug back in the force balance $A_y + B_y = P$, we get $A_y + \frac{P}{2} = P$, so $A_y = \frac{P}{2}$.

So, the support reactions are $A_y = P/2$ upward, $B_y = P/2$ upward, and $A_x = 0$. Each support takes half the load, which is intuitive for a symmetric simple beam with a center load.

Interpretation: This result makes sense: the pin and roller share the load equally. If you imagine the physical scenario, a 1000 N load in the middle would cause 500 N reaction at each support. The roller didn't slip because there's no horizontal force; the pin's horizontal reaction was zero (no push from anywhere). If the load were off-center, you'd get a different split – the closer support takes more. You could do the same math with distances adjusted. The method remains: $\sum F_y$ and one well-chosen $\sum M$ yields the answers. If you had mistakenly added a horizontal reaction at the roller in your unknown list, you'd have 4 unknowns. You might write $\sum F_x = A_x + B_x = 0$. Without a horizontal load, that would give $A_x = -B_x$ (not individually zero, which could mislead you). The moment equation about A would be unaffected (since that fictitious B_x passes through A if we consider A at left end and B at right end? Actually B_x would also pass through A horizontally? Not exactly, but if you did about A, B_x would create a moment since it's at the top? Hmm). The point is, that extra unknown would mess up consistency unless you realize it must be zero. This is why correctly recognizing support reactions is so important.

Another quick example: a **cantilever beam** (fixed at left wall A, free at right end) with a downward load P at the free end. The support at A is fixed, so we have potentially A_y (upward force), A_x (horizontal, though here no horizontal load P so likely $A_x = 0$), and M_A (fixing moment). $\sum F_x = 0$ yields $A_x = 0$. $\sum F_y = 0$ gives $A_y - P = 0$ so $A_y = P$ (the wall holds up all the load). Now $\sum M_A = 0$: Taking moments about A, the only moment comes from the load P at distance L (trying to rotate the beam clockwise around A) and the reaction moment M_A at the wall (which we assume if drawn on

FBD as resisting clockwise rotation, it would be counterclockwise if P is clockwise, depending on sign convention). So equation: $M_A - P \cdot L = 0$. Thus $M_A = PL$. The wall provides an upward force equal to the load and a counterclockwise moment equal to PL to keep it static. If you forgot to include M_A in your thinking, you'd find $A_y = P$ but then $\sum M$ about A would be unbalanced (it would come out PL unaccounted for, implying rotation). The reaction moment is what balances it. A common exam question is to give a cantilever with a load and ask for the reaction forces and moment – which is exactly what we solved. So if you know your support types, it's straightforward.

Exam Handbook Search Cues (Not affiliated with or endorsed by NCEES): *support reactions, pin support, roller support, fixed support, statically determinate* (The exam reference handbook might list "Equilibrium of rigid bodies (e.g., support reactions)" in the exam specs section, reminding you that support reactions are part of the tested knowledge. It also depicts some beam diagrams in Mechanics of Materials sections, but generally, the handbook expects you to know what each support symbol means. If you forget, searching "support" or "equilibrium rigid bodies" could jog your memory with the spec language or a definition. Ultimately, memorizing the reaction capabilities of pins, rollers, and fixed supports is key – the handbook isn't likely to spell out "a pin has two reactions" explicitly.)

Footnotes:

- *Naming conventions:* In textbook problems, you often see supports labeled with letters (A, B, C…) and then reactions named according to direction, like A_x, A_y or sometimes A_H, A_V (horizontal, vertical), and moments as M_A. Use whatever naming makes sense, but be consistent. If the exam diagram labels a support "A," it's good form (and clarity) to call its reactions A_x, A_y. If not, a generic R_1, R_2 is fine as long as you define them. Don't mix naming schemes mid-problem. Also, don't confuse internal forces with support reactions: A_x usually means a support reaction at A, whereas something like F_{AB} might mean force in member AB. Context will keep these clear.

- *Round-off and units:* When solving for support reactions, keep an eye on units (I know we harp on this, but it's a common slip). If a load is given in kips (thousands of pounds) and distances in feet, the moment will come out in kip-ft. If you then want it in, say, lb·ft, multiply by 1000. The exam may mix units, especially in structural questions (inches vs feet, or kN vs N). Convert to a consistent set before applying equilibrium equations. Write units in your intermediate steps to avoid mistakes. For instance, $M_A = P \times L = (200 \text{ lb}) \times (3 \text{ ft}) = 600 \text{ lb·ft}$. If you accidentally used 3 inches instead of 3 ft, you'd get 600 lb·in, which is 50 lb·ft – way off.

- *Reality check on directions:* After solving, check if your support reactions make sense directionally. If you get a negative A_y in a scenario you assumed up, it means the support is actually pulling down on the structure. Does that ever happen? It can if there's an overturning moment or another support pushing up harder, causing that support to actually be in tension. For example, if a beam is bolted down at A and has an upward force at the far end (like someone lifting the beam's tip), you could get a negative reaction (meaning the bolt at A is in tension trying to hold the beam down). So negative isn't "wrong" – it's information. Interpret it: maybe the left support isn't actually touching (if it were a contact support, a negative normal force would mean lift-off). The FE exam sometimes asks conceptually, like "if the second support exerts a negative reaction, what does it mean physically?" The answer: that support might lift off or not engage because the other support or a fixed connection is holding things. In structural design, you obviously don't want a support to lift off unless it's intended (like a gap). But in exam statics, a negative reaction just means your initial assumed direction was opposite, so the actual force direction is opposite to what you drew. Mark it clearly and move on.

- *Multiple supports of same type:* If you have, say, two pin supports (like a beam on two pin supports which is actually unstable because it can roll horizontally), the problem is under-constrained in real life. But in an ideal static problem, you might still set it up – you'd find one of the horizontal reactions negative of the other from $\sum F_x = 0$, basically indicating the beam could shift if nudged. The exam probably won't give you an unstable configuration without telling you something to secure it. But be aware: if supports don't prevent a certain motion (like both supports allow horizontal sliding), that motion is a **mechanism** – meaning the structure isn't stable in that direction. No matter how you write equations, you won't get a unique solution for the unsupported direction (it'll turn out something like 0=0, indicating freedom). For the FE, just ensure you include reactions where supports do restrain and **don't** invent them where they don't. Stability is usually assumed or obvious in exam problems.

Variations and Special Cases:

Inclined roller or rocker: We touched on this, but a quick example: a beam on an incline with a **rocker support** (similar to a roller, just a curved surface) will have a reaction along the line of action normal to that incline. Sometimes, instead of a roller symbol, you might see a **smooth surface** contact drawn – for instance, a block resting on an incline (no friction). The reaction is normal to the incline. You treat it like a roller for equilibrium purposes (one force perpendicular to surface). Just be prepared to resolve that into components if needed. A **rough surface** would add a friction force parallel to the surface (if impending or actual motion is considered), but that ventures into friction topic. In pure equilibrium without friction, surfaces only give normal forces.

Pinned connection vs. pinned support: Don't confuse a *pin support* (which connects to ground/foundation) with a *pin joint* connecting two members. Both are "pins" in that they allow rotation. The difference: a pin support's other side is ground (which can supply whatever force needed up to failure), whereas a pin joint connects two free bodies, so any force it supplies to one comes from the other (Newton's third law pair). The analysis approach is similar (a pin joint force appears as unknowns on both member FBDs, equal and opposite). If the exam asks for support reactions, they mean forces at the supports (to ground). If they ask for forces in pins, they're talking internal forces between members. Always clarify what the terminology is referring to in the problem context.

Partial fixity (propped cantilevers): A less common case on the FE (but worth a mention) is something like a beam with a fixed end and a simple support at the other end – often called a propped cantilever. This has 4 unknowns (2 forces + 1 moment at fixed, and 1 force at simple support) for 3 equations, making it indeterminate. The exam likely won't ask you to solve an indeterminate reaction using deflection, but they could ask conceptually which support carries more load or how the moment distribution qualitatively looks. Just recall: adding more support constraints than necessary can "lock in" extra forces (like thermal expansion causing forces, etc., which is beyond statics). In pure statics, recognize indeterminacy so you don't frustrate yourself trying to solve by equilibrium alone.

Distributed loads conversion: Often, a uniformly distributed load on a beam is given (say w = 5 kN/m across a span). When finding support reactions, it's useful to convert that distributed load into a single resultant force on the FBD (for the whole beam's equilibrium). The resultant of a uniform load w over length L is wL (acts at the midpoint of that distribution). So you'd draw an equivalent point force $P = wL$ at the centroid of the load (mid-span if uniform) on your FBD for the purpose of computing support reactions. This makes the math easier: supports' $\sum F_y$ just balance that wL total, and $\sum M$ uses that resultant at its location. This is valid because for equilibrium of the whole rigid body, the distributed load's effect is equivalent to its resultant. Just don't forget: if the problem later asks for internal shear/moment, you'd consider the distribution again in detail. But for support reactions, feel free to replace distributions by their single equivalent force. The exam often expects that shortcut to save time.

Non-standard supports: In some cases, a problem might feature something like a **cable support** (a cable can only pull in tension along its length – so treat it like a roller in that it has one force along the cable, and you might have to find its angle or components). Or a **spring support** (resisting force proportional to deflection – if in static equilibrium, it'll compress until force $k\Delta$ balances things – could be an extra unknown Δ unless given or if asked for deflection). Those delve into other topics (mechanics of materials or dynamics with springs), but if encountered, you still apply equilibrium with the appropriate reaction expression. Just keep the core idea: constraint dictates reaction. If it's flexible (like a spring or a cable's length can change), the reaction can adjust with deformation. Rigid supports have whatever force needed to enforce no movement.

With a solid grasp of these support reaction principles, you'll approach statics problems methodically: **identify supports ⇒ draw FBD ⇒ write ∑F/∑M equations ⇒ solve for reactions.** It becomes almost mechanical with practice, which is exactly what you want going into the FE exam – a reliable, repeatable procedure for equilibrium of rigid bodies.

Topic 04 - Frames and Trusses

Frames and trusses are structural systems you'll meet on the FE Mechanical Exam. A **frame** is a structure with members rigidly joined (so members can carry bending moments), whereas a **truss** has members pinned at its joints, carrying only axial forces. In statics problems, we usually focus on *planar trusses*: 2D, pin-jointed frameworks loaded only at the joints. These are common in bridges, roofs, and towers. On exam day you might see a truss with pinned supports and applied loads, and you'll be asked to find the force in each member (tension or compression).

- **Frames vs. Trusses:** Frames have fixed (moment) connections; trusses have frictionless pins at joints. Only trusses (pin-jointed) are solved with the method of joints in statics.
- **Why it matters:** Truss problems test your ability to apply equilibrium at each joint and recognize structural assumptions (like two-force members and zero-force members). Mastering truss analysis is essential for any statics exam question involving internal member forces.
- **Typical question:** "Given the geometry and loads of a pin-jointed truss, find the axial force in each member." You will draw free-body diagrams of joints and use $\sum F_x = 0$and $\sum F_y = 0$to solve.

K06.T04.S01 – Planar Truss Analysis (Method of Joints)

- **Principle Introduction:** A truss is a network of straight members connected by frictionless pins. Under the method of joints, you isolate each pin-joint and enforce equilibrium: the vector sum of forces must be zero. Members in a truss are assumed *two-force members*, so each member's force acts along its axis, and only tension or compression occurs. Typically, you start by finding support reactions (treat the whole structure as one rigid body and use overall $\sum F_x = 0, \sum F_y = 0, \sum M = 0$). Then pick a joint with at most two unknown member forces (often an outer joint) and apply $\sum F_x = 0, \sum F_y = 0$to solve for them. Repeat joint by joint, carrying known forces forward. Zero-force members (members carrying no load) often appear when a joint has three members with no external load on one; you can identify and skip these to simplify the math. In short: **isolate a joint, draw a free-body, write $\sum \boldsymbol{Fx} = \mathbf{0}, \sum \boldsymbol{Fy} = \mathbf{0}$, and solve**. (Remember: keep it planar – out-of-plane forces or bending aren't included.)

- **Visual:** A typical joint free-body shows the pin with its connected members. For example, consider joint A connecting horizontal member AB and vertical member AC, with a downward external load *P*. The forces in AB and AC (label them F_{AB} and F_{AC}) are drawn along the members. By balancing horizontal and vertical components at A, one solves $F_{AB} and F_{AC}$. (See diagram below.)

Exam Handbook Search Cues (Not affiliated with or endorsed by NCEES): truss analysis; method of joints; two-force member; pin-jointed structure; zero-force member. *(These are keywords you would look up in the official exam handbook for reference, not to be cited directly.)*

Footnotes:

- Axial forces (F) are positive for tension (pulling apart) and negative for compression (pushing together) by our sign convention.
- Use consistent force units (e.g. N or lbf) throughout. Members' lengths appear in geometry only; no unit conversion here unless an angle requires it.
- Truss members are assumed weightless unless a joint load is specified; if a member has weight, include it as a joint load.
- Joints are treated as frictionless pins (no moment equilibrium needed at a pin).
- Reaction forces at supports must be found first if not given (via overall equilibrium of entire truss).

Variations & Related Forms:

- *Method of sections:* When you need only one or two member forces, sometimes it's faster to cut through the truss (method of sections) rather than solve joint-by-joint. However, the exam usually tests method of joints explicitly.
- *Static determinacy:* A planar truss is statically determinate if $m + r = 2j$ (members + reactions = twice joints). If not, the structure is indeterminate or unstable (avoid in basic problems).
- *Symmetric truss:* If loads and supports are symmetric, corresponding member forces will be equal. You can exploit symmetry to reduce work.
- Zero-force members: Trusses often include members that carry no axial load under a specific loading pattern. Two common patterns signal a zero-force member when a joint has no external load or support:
    - If only **two members** come together at that joint and they are not collinear, both must have zero axial force.
    - If **three members** meet and two lie along the same straight line, the third, 'odd' member has zero axial force.

  Spotting these cases lets you cross out members early and shorten the algebra. Similarly, if two collinear members meet a third one with no load, the non-collinear member is zero-force.
- *Space (3D) trusses:* Real 3D trusses require $\sum Fx = \sum Fy = \sum Fz = 0$ at each joint. This is beyond most FE scope (stick to planar cases).
- **Typical magnitudes:** Member forces scale with the applied loads and geometry. There's no fixed 'typical' value – calculate based on your given data and units.

- **Special Note (Calculator):** There is no special built-in formula to type; you are just solving linear equations. On exam calculators (Casio fx-991, TI-36X, HP 33s, etc.), you can use the simultaneous equation solver or algebraic solve mode. For example, set up the two equations for $\sum Fx$ and $\sum Fy$ and use the solver to find unknowns. Always check your calculator's angle mode (degrees vs radians) if using sine/cosine for projections. Enter negative numbers carefully (e.g. use parentheses, like *(-50)* for –50).

Explanation & Analysis:

Isolate and Free-Body: Start with the whole truss: sum moments to find any unknown support reactions. Then turn to the joints. Pick a joint with only two unknown member forces (often a support joint or an end joint). Draw the joint's free-body with all external forces and the unknown member forces (assume they pull away from the joint – tension positive). Label angles of the members from the horizontal.

Apply Equilibrium: Write two equilibrium equations for that joint:$\sum F_x = 0, \sum F_y = 0$.

For each member force F_{ij}, decompose it into $F_{ij} \cos \theta_{ij}$ horizontally and $F_{ij} \sin \theta_{ij}$ vertically. Include any external loads or known reaction components. Solve the two equations (usually one for F_x and one for F_y) simultaneously for the two unknown member forces. (If you get a negative result, that member is actually in compression, opposite to your original guess.)

Proceed Joint-by-Joint: With those forces known, move to an adjacent joint that now has only two unknowns remaining. Repeat the same steps: draw free-body, apply $\sum Fx = 0, \sum Fy = 0$, solve. Each solved member force becomes a known value or external on the next joint. Continue until all forces are found.

Check Consistency: Ensure each member's force is solved only once; a member force from one joint appears with opposite sign on the adjacent joint. A good check is that every equation is satisfied and no equilibrium is violated. Also verify units and sign conventions.

Term Analysis: In $\sum F_x = 0$ and $\sum F_y = 0$, each term is a force component (in N or lbf). For example, a horizontal member force appears only in the x-sum; a vertical member only in y-sum. External forces appear in whichever direction they act. Make sure angles θ_{ij} are measured from the positive x-axis, using cos for horizontal projection and sin for vertical. Double-check that you haven't mixed up sine and cosine for a given member.

- **Common Pitfalls:** Forgetting an external load or reaction component in the equilibrium equation is a classic error. Also watch your sign for assumed tension vs compression. If a load P pulls down, its contribution in $\sum F_y$ is $-P$ (taking up as positive). Wrongly dropping a zero-force member can cause you to have fewer equations than unknowns. Always systematically account for all forces on the joint.

Follow these steps methodically, and you'll be able to solve any planar truss by the method of joints. Draw clear diagrams, label forces, and carry units through your work. You're essentially balancing a little "force scoreboard" at each joint so that nothing "tips over" – that's the heart of statics. Good luck applying it on exam day!

K06.T04.S02 – Planar Truss Analysis (Method of Sections)

Core idea: A planar truss consists of **two-force members** (members carrying only end loads) connected at frictionless pins. In method of sections, we "cut" through the truss (at most three members) and draw a free-body of one side. We then use the equilibrium equations ($\Sigma F_x = 0, \Sigma F_y = 0, \Sigma M = 0$) on that cut section to find unknown member forces.

Why it works: Each cut isolates internal forces in up to three members. By choosing the cut carefully (so that it passes through the targeted member(s) and yields no more than three unknowns), we can directly compute those forces via moments and force balances.

When to use: Use sections when you need the force in a specific member (or a few members) of a statically determinate truss. If the truss has many members and solving joint-by-joint would be long, sections is faster.

Key point: Before cutting, solve for external reactions at supports (if not given). Then take the free-body of one side of the cut. Label all forces (external loads, support reactions, and internal member forces on the cut section) and apply ΣM and ΣF.

Strategy tip: In picking a cut, try to have as many unknown forces as possible intersecting at a convenient point. Then taking moments about that point will eliminate them, allowing one unknown to be found quickly.

Exam Handbook Search Cues (Not affiliated with or endorsed by NCEES): *planar truss*, *method of sections*, *two-force member*, *statics equilibrium*, *sum of moments*. These keywords help find truss analysis reminders in the exam handbook.

Footnotes: - Check **static determinacy**: For a planar truss, use $m + r = 2j$ (members + reactions = 2 × joints) to ensure the truss is statically determinate.

- When you cut the truss, **cut no more than 3 members**. Otherwise you have more unknowns than equilibrium equations.

- **Sign convention:** By exam convention, treat tension (member pulling away from joint) as positive. If you assume a direction (e.g. tension) and get a negative answer, it means the true force is compression.

- If member weights or distributed loads are not given, assume **members are weightless** and all loads are applied only at joints.

- All members meet at **frictionless pins**: no bending moments exist internally, only axial forces.

Variations & Related Concepts:

- *Method of Joints:* Another way to find truss forces by isolating each joint (solving $\Sigma F = 0$ in both directions). Sections targets specific members directly, while joints solve systematically for all.

- *Zero-force members:* A joint with no external load and only two non-collinear members leads to both members carrying zero force.

Recognizing this can simplify a section cut (you can ignore those members).

- *Statics vs frames:* A truss is different from a rigid frame (in a frame, members carry moments/shear). Method of sections applies only to pure trusses (axial members).
- *Space truss (3D):* Out of scope for FE mechanical (stick to planar).

Special Notes: No special calculator syntax is needed beyond ordinary arithmetic. Just remember to resolve forces into x/y components correctly and solve the linear equations step by step.

Definition/Note Passport – Two-Force Member: A member loaded only at its two end points, so its internal force is purely axial (tension or compression). *Where it matters:* In truss analysis, each member is treated as a two-force member, which greatly simplifies equilibrium since no shear or moment are internal. *Pitfall:* If any additional load or moment acts on a member between its ends, the two-force assumption fails (that member could then carry bending or shear). *Quick check:* True or False; A bar pinned at both ends with no intermediate loads has no bending moment (True).

Equation Passport – Static Equilibrium: Ensures a free-body has no net force or moment (used to solve for unknown forces in the cut section).

$$\sum F_x = 0, \quad \sum F_y = 0, \quad \sum M = 0.$$

- **Variables:** F_x, F_y are force components in the x and y directions (in N or lbf). M is moment (in N·m or lbf·ft).

- **Assumptions:** Rigid body in static equilibrium (no acceleration). All forces lie in the plane of the truss.

- **Use:** Apply these equations to the free-body of the truss section after the cut. Don't confuse with beam bending formulas; here we only balance forces and moments on a rigid body.

- **Common pitfalls:** Forgetting to include reactions or sign errors when summing moments. Always draw the full free-body first, label forces (choose positive directions), and then apply Σ.

Explanation & Analysis:

To find a member's axial force by sections, *first draw the full truss with supports and applied loads and compute any support reactions* (e.g. by taking moments on the whole truss). Next, **choose a section** through the target member(s): imagine "cutting" the truss along a line that passes through up to three members whose forces you wish to find. Draw the free-body diagram of one side of the cut (either left or right portion). On this FBD, label all known forces (applied loads or support reactions) and **unknown axial forces** in the cut members (typically drawn as tension or compression arrows).
1. **Apply $\boldsymbol{\Sigma M = 0}$** about a clever point: If two unknown member forces intersect at a single node on your FBD, take moments about that node. This eliminates those two unknowns in the moment equation, allowing you to solve for the third unknown force.
2. **Apply $\boldsymbol{\Sigma F_x = 0}$** and **$\boldsymbol{\Sigma F_y = 0}$**: After finding one force, use the force-balance equations in the horizontal and vertical directions to solve the remaining unknowns. Each equation will involve components of the axial forces (use trigonometry if the members are not horizontal/vertical).
3. **Check consistency:** The number of unknowns should not exceed three (for planar equilibrium). If you have fewer unknowns, you can still write all three equilibrium equations – one or more will simply validate the solution. If there are more than three unknowns, split into two sections or use a different cut.

Term-by-term: In the moment balance $\Sigma M = 0$, each term like $N_i \cdot d_i$ represents the moment of an axial force N_i about the chosen pivot point. For instance, d_i is the perpendicular distance from the pivot to the line of action of the member force N_i. Units check: if N is in newtons (N) and d in meters (m), the moment is in N·m. For ΣF_x and ΣF_y, each component of an axial force is $N_i \cos\theta$ or $N_i \sin\theta$, where θ is the angle of the member. A common mistake is forgetting to include the correct sign for a component (treat right/up as positive by convention, for instance). If an assumed force direction leads to a negative result, that simply means the force is opposite the assumption (e.g. compression instead of tension). Always double-check geometry: use consistent angle measurements and keep track of units (mixing degrees and radians could confound trigonometric calculations, though most calculators handle this automatically if set correctly).

For example, a simple triangular truss has 3 members, 3 joints, and 3 reactions (2 supports + 1 pinned joint reaction), so $3 + 3 = 2(3)$, confirming determinacy.

K06.T04.S03 – Determinacy and Stability of Plane Trusses

Principle: A planar truss is statically determinate (and stable) if and only if the number of unknowns (internal member forces and support reactions) equals the number of equilibrium equations available. In a 2D truss, each of the j joints provides two equilibrium equations ($\sum Fx = 0, \sum Fy = 0$), so a total of $2j$ equations. The unknowns are the m member forces plus the r reaction components. Setting $m + r = 2j$ ensures these balance. If $m + r$ is less, there aren't enough constraints to prevent collapse (mechanism). If $m + r$ is more, there are extra members/reactions that static equilibrium alone cannot resolve (redundant). This rule gives instant insight into the structure's behavior.

Key idea: Count and compare, don't blindly assume a truss is solvable. Use the $2j$ rule to **pre-check** before doing any joint/section analysis.

Determinacy Condition for a Plane Truss – determines if a planar pin-connected truss can be solved by static equilibrium alone.

- **Professional equation:**

$$m + r = 2\,j.$$

- If $m + r < 2j$: *unstable* (insufficient members/supports, mechanism).
- If $m + r > 2j$: *statically indeterminate* (redundant internal forces or supports).

Variables and units:

- m – number of members (straight bars) in the truss (dimensionless count).
- r – number of independent support reaction components (dimensionless).
- j – number of joints (pin connections) (dimensionless).

Assumptions and scope:

- Plane (2D) truss: members only carry axial force; all joints are frictionless pins (no moments at joints).

- Each joint yields 2 equilibrium equations ($\sum Fx = 0, \sum Fy = 0$).
- Reaction components counted correctly: pinned support provides $r = 2$ (horizontal + vertical), roller provides $r = 1$. (No bending or torsion in members.)
- Truss must be geometrically stable (arranged in non-collinear fashion). Note: even if $m + r = 2j$, a "degenerate" geometry (e.g. all joints in a straight line) is actually unstable.
- No internal hinges (i.e., $c = 0$ in frame formula).

Limit tests (sanity checks):

- As $m + r$ **increases beyond** $2j$, extra members or supports cause redundancies (internal forces that can't be found by statics alone). Physically, the truss is "over-braced."
- As $m + r$ **decreases below** $2j$, the structure has too few constraints and becomes a mechanism (unstable). It will deform under load.
- **Use vs. sibling formulas:**
- Use this criterion for planar, pin-jointed trusses.
- For a **space (3D) truss**, each joint gives 3 equations, so use $3m + r = 3j$.
- For a **planar frame** (with bending members), the equation is $3m + r = 3j + c$, where c accounts for any internal hinge conditions.

Common exam traps:

- *Reaction count:* Failing to count support reactions correctly. Remember: a pin support has **2** reaction components (horizontal and vertical), a roller has **1**. Fixed support in a truss context usually still contributes 2 (since no moment equilibrium is needed here).

- *Wrong formula:* Applying the $2j$ rule to a frame with bending or a 3D truss. Always check if it's really a simple pin-jointed truss.
- *Member count:* Including a member that isn't actually connected (or missing one). Double-check how many bars connect to each joint.

- *Hidden instability:* Trusting $m + r = 2j$ without checking geometry. For example, three collinear joints (even with the right count) will flop like a hinge.

- *Symbol confusion:* Don't confuse m (members) with mass or moment, and r (reaction count) with a reaction force (symbol usually R).

Exam Handbook Search Cues (Not affiliated with or endorsed by NCEES): *plane truss; static analysis classification; statically determinate; reaction components; truss stability.*

Footnote: Members m, joints j, and reactions r are pure counts (dimensionless). Do not assign units to them.

Footnote: When counting reactions r, treat a pinned support as 2, roller as 1. (Internally, don't count moments at joints.)

Footnote: A truss that meets $m + r = 2j$ can still be unstable if its shape is bad. Always visualize the geometry: every joint should be part of at least one triangle.

Footnote: For this FE topic, zero-force-member rules (not covered here) can simplify count by eliminating bars that carry no load, but **only use those if explicitly needed after checking determinacy**.

Variations:

- Space truss (3D): Each joint has 3 equilibrium equations, so for a determinate space truss use $3m + r = 3j$.
- Planar frame with bending: Each joint has 3 equations ($\sum Fx$, $\sum Fy$, $\sum M$), so the general formula is $3m + r = 3j + c$, where c is any known internal constraint (e.g., an internal hinge adds $c = 1$). In practice, frames often break into simpler elements for FE problems.
- Rearranged form: It's common to see $m = 2j - r$ for a determinate truss; it's algebraically the same condition.
- Example values: A simple truss with 4 joints and 5 members, with 3 reactions gives $5 + 3 = 8 = 2(4)$, determinate. Add a diagonal (m=6): $6 + 3 = 9 > 8$, indeterminate. Remove a member (m=4): $4 + 3 = 7 < 8$, unstable.

Special Notes (Calculator Input): This is an integer count check, so no special calculator input is needed. Just perform simple arithmetic. On Casio/HP/TI calculators, you might simply type the numbers or use the basic sum function. (Example: calculate 2*j and compare to m+r.) No additional formula entry is required.

Explanation: When you encounter a truss problem, **start by verifying determinacy.** This tells you if equilibrium alone suffices. For a planar truss, you get exactly 2 equilibrium equations per joint. The unknowns are the axial forces in the m members plus the r support reactions. If $m + r = 2j$, you have exactly as many equations as unknowns. Equilibrium methods (method of joints or sections) can then find a unique solution. If $m + r < 2j$, some equations are "missing" so the structure can move (unstable). If $m + r > 2j$, extra unknowns mean there are redundancies; you'd need additional compatibility equations (beyond exam scope) to solve. The FE exam typically expects you to identify determinate vs. indeterminate, and then only solve the determinate cases.

Analysis:

- m**:** Number of members (bars) in the truss. Count each distinct two-node member once. Units: – (no units).
- j**:** Number of joints (pin connections). Each location where members meet. Units: –.
- r**:** Number of reaction components at supports. For each support, count how many independent force directions it restrains (pin = 2, roller = 1). Units: –.
- **Interpretation:** Each joint provides 2 equilibrium equations ($\Sigma Fx = 0, \Sigma Fy = 0$). Thus the total number of equations is $2j$. Equating $m + r$ to $2j$ ensures a one-to-one match.
- **Unit consistency:** Since all are counts, the equation is dimensionally consistent (dimensionless = dimensionless). Don't insert any units or factors.

Common pitfalls in usage:

- Forgetting to count a support's reaction (e.g. treating a pin as giving only 1 reaction).
- Using a frame formula (3D) on a truss or vice versa. Always confirm it's a planar, pin-connected truss.
- Assuming a complicated truss is solvable without checking determinacy (this can waste time). Always *count first*.
- Noticing a statically indeterminate answer: The FE exam won't require you to solve an indeterminate truss. If you get $m + r > 2j$, typically the answer is just "indeterminate" or "redundant".
- If $m + r = 2j$ but the truss looks like a mechanism (e.g. a square with no diagonal is actually unstable), point out the geometry issue.
- **What happens if values change:** Decreasing r (e.g., removing a support) or removing a member decreases $m + r$, pushing toward instability. Adding members or an extra support increases $m + r$, leading to redundancy. These sanity checks help catch errors in counting.

K06.T04.S04 – Classification of Supports and Determinacy

Supports: In a planar (2D) structure each support provides a certain number of reaction forces. A **pinned support** (a hinge) gives two independent reactions (horizontal and vertical), a **roller** gives only one (vertical, assuming a smooth ground), and a **fixed support** gives three (horizontal, vertical, and moment). Count these accurately when computing r, the total number of independent support reactions.

Static determinacy: A structure is *statically determinate* if you can find all internal forces and reactions using only the equilibrium equations. It is **unstable** if it has too few constraints (it would collapse), and **statically indeterminate** if it has extra constraints (so equilibrium alone isn't enough).

Determinacy formulas: For a **plane truss** (pin-jointed), the equilibrium equations give two equations per joint, so the criterion is $m + r = 2j$, where m = number of members, j = number of joints, and r = number of support reactions. For a **plane frame** with rigid joints (plus any internal hinges), each joint gives three equations, so the criterion is $3m + r = 3j + c$, where c counts additional equilibrium conditions (e.g. one per internal hinge). If the left side is less than the right, the structure is unstable; equal means stable and statically determinate; greater means statically indeterminate.

Applications: To solve problems, identify whether the system is a truss or rigid frame (axial-only vs bending members), count m, j, r, (and c for frame hinges), then plug into the appropriate formula. This will tell you if the structure "checks out" before attempting force calculations.

Exam Handbook Search Cues (Not affiliated with or endorsed by NCEES): static determinacy; support reaction components; plane truss statics; frame stability; structure classification.

Footnotes: Pinned supports yield 2 unknown reactions (horizontal and vertical); a roller yields only 1 (vertical); a fixed support gives 3 (vertical, horizontal, moment). The variable c counts internal equilibrium conditions (e.g. a pin joint means zero internal moment, providing one additional equation). All quantities m, r, j, c are pure counts (dimensionless).

Variations, Related Forms, Typical Values:

- *Degrees of indeterminacy:* Sometimes it's useful to compute $m + r - 2j$ (truss) or $3m + r - (3j + c)$ (frame) to see how many extra (positive) or missing (negative) equations there are. Zero means determinate.

- *Unstable case:* If $m + r < 2j$ (truss) or $3m + r < 3j + c$ (frame), the structure lacks sufficient support and will be unstable (rigid-body motion). In practice that means the problem is ill-posed unless a support is added.

- *Indeterminate case:* If $m + r > 2j$ or $3m + r > 3j + c$, there are more unknown forces than equilibrium equations – the structure has **redundant** supports. Solving it requires extra compatibility/deflection methods (beyond basic statics) or dropping a redundant reaction. Such cases occasionally appear on the FE as a classification question (don't attempt a full solution by hand).

- *3D structures:* The above formulas apply only to planar (2D) frames and trusses. Space (3D) frames and trusses have different counts (not on the FE), so stick to 2D contexts.

Special Notes: These calculations are simple arithmetic. On any exam-allowed calculator, just enter the values of m, r, j, c and compute $m + r - 2j$ (or $3m + r - (3j + c)$); there are no special functions required. For HP or Casio models, ensure you input parentheses properly (e.g. 3*m + r - (3*j + c)).

Explanation & Analysis: This criterion is used to *check* whether a given frame or truss can be solved by equilibrium. In practice, **step 1** is to count your unknowns and available equations: each joint gives 2 equations in a truss and 3 in a rigid frame. **Step 2** is to count unknown forces: each member's axial force (and bending/moment if rigid) plus each support reaction. For a truss, unknowns = $m + r$; available equations = $2j$. Set them equal: $m + r = 2j$. For a frame, unknowns = $3m + r$ (members can have bending moments) and equations = $3j + c$ (with c additional hinge conditions) so $3m + r = 3j + c$. Each symbol: m = number of members/bars, r = number of independent support reactions (count 2 per pin, 1 per roller, etc.), j = number of joints, and c = number of known hinge/zero-moment conditions. There are no units – these are pure counts.

Common pitfalls: The most frequent mistake is miscounting reactions: **don't** treat a roller as having two forces – it only provides a perpendicular support force. Likewise, make sure to include a horizontal reaction for a pinned support, even though it looks like a simple triangle (many skip it). Also be clear whether the joint is rigid or pinned: applying the truss formula to a rigid frame (or vice versa) will give the wrong result. If the frame has an internal hinge, remember $c = 1$ for each hinge (adding one equilibrium equation). A missing c term can make an otherwise determinate frame appear indeterminate. Finally, watch that you use the *correct* formula: *truss* (pin joints) uses $m + r = 2j$, while *frame* (rigid joints) uses $3m + r = 3j + c$.

If you compute the left minus right side:

- **Zero** means determinate (stable) – you have exactly enough equations.
- **Negative** means unstable – some degree of freedom is left uncontrolled (the structure would move if loads were applied).
- **Positive** means statically indeterminate – there are redundant supports or members.

For example, consider a simple triangular truss of 3 members and 3 joints, with a pinned support at one corner (2 reactions) and a roller at another (1 reaction). Then $m = 3$, $j = 3$, $r = 3$. Checking $m + r = 6$ vs $2j = 6$ gives equality, so the truss is **statically determinate**. This matches the formula: two equations per joint (6 total) and 3 unknown member forces plus 3 support reactions (6 total). If instead there had been 4 reactions, we would have $m + r = 7$, making it indeterminate. Always perform this count **before** diving into solving – it tells you whether a straightforward equilibrium solution is even possible on the exam.

Topic 05 - Centroids and Moments of Inertia

Topic Introduction: Centroids and moments of inertia are fundamental properties of shapes that frequently appear in FE Mechanical Exam problems. The centroid is the geometric "balance point" of an object (area, line, or volume), crucial for determining where distributed forces act or how structures will balance. The area moment of inertia (second moment of area) measures how a shape's area is distributed relative to an axis, directly influencing bending and deflection in mechanical components. On exam day, you'll encounter questions asking for the centroid of a composite section or the moment of inertia about a specified axis – often to plug into formulas for stress or deflection. This chapter will ensure you can confidently compute these properties and quickly locate the relevant formulas in the exam reference. We'll cover the centroid formulas for various geometries, methods to find area moments of inertia including for composite shapes, the parallel-axis theorem for shifting axes, and how to use standard shape property tables effectively. Mastering these tools will help you avoid common pitfalls (like mixing up axes or units) and solve typical statics problems efficiently.

K06.T05.S01 – Determining Centroids of Areas, Lines, and Volumes

Concept of Centroid: The centroid of an object is its geometric center – the average location of its area, length, or volume. For a uniform plate or lamina, the centroid is the same as the center of mass or "balance point" where it would perfectly balance on a point support.

Applications: Centroids are used to find points of action of distributed loads (e.g. the resultant of a triangular pressure load acts at the area centroid of the triangle) and to design structures for stable support. They simplify analysis by allowing distributed effects to be represented as a single equivalent force at the centroid.

Computing Centroids: The centroid coordinates are found by taking a weighted average of position coordinates. For continuous shapes, this means integrating: summing up small pieces of area (or length, volume) times their position, then dividing by the total area (or length, volume). For composite shapes, you can sum the contributions of each part (with each part's area and centroid position) to get the overall centroid.

Line vs Area vs Volume: The same principle applies to lines (length), areas, and volumes – only the "weight" changes (length elements for lines, area for surfaces, volume for solids). In all cases, assume uniform density unless told otherwise, so geometry alone defines the centroid.

Symmetry Insight: If a shape has a symmetry axis, the centroid lies on that axis (e.g. the centroid of a symmetric beam cross-section is at its geometric center). Conversely, if a shape is not symmetric, the centroid will be offset toward the heavier (larger or longer) side.

Exam Handbook Search Cues (Not affiliated with or endorsed by NCEES): centroid; center of area; center of gravity; composite centroid

Equation Passport – Centroid Formula (Area Example)
Purpose: Computes the coordinates of an area's centroid (geometric center) relative to reference axes.

Equation: $x_c = \frac{1}{A}\int x\, dA, \qquad y_c = \frac{1}{A}\int y\, dA,$
where $A = \int dA$ is the total area. (For a set of point masses or discrete areas, replace the integral with $\sum m_i x_i$ and $\sum m_i$ etc.)

Variables:

- x_c, y_c – Coordinates of the centroid (m) measured along the x and y axes from the chosen reference (e.g. from a corner or datum).
- x, y – Coordinates of an infinitesimal area element dA (m).
- dA – Differential area element (m²).
- A – Total area of the shape (m²).

Assumptions & Scope:

- Shape is homogeneous (uniform density or thickness), so the centroid depends only on geometry.
- The reference axes for x and y must be specified (typically edges or symmetry axes of the shape). Coordinates x_c, y_c are measured from that reference.
- Valid for planar areas; analogous formulas exist for line lengths and volumes (use dL or dV in place of dA and total length L or volume V in place of A).
- In the FE exam, centroid problems usually involve simple shapes or composite areas rather than complex integrals, since basic centroid locations for standard shapes are known or given.

Limit Checks:

- If the shape is symmetric about an axis, x_c or y_c will lie exactly on that axis (e.g. a uniform rectangle's centroid is at its geometric center).
- If part of the area extends far outward, the centroid moves in that direction. Conversely, if you trim away area on one side, the centroid shifts toward the remaining area. (As one area portion shrinks to zero, the centroid approaches the centroid of the remaining portion.)

Use vs. Related Formulas: Use the centroid formula (first moment of area) for finding balance points of geometry. Do not confuse it with the second moment of area (moment of inertia) formulas, which involve x^2 or y^2 – those compute a different property altogether. For locating a center of mass with non-uniform density, use a weighted form (replace area A with mass $m = \rho A$), but for uniform materials the centroid and center of mass coincide.

Common Pitfalls:

- **Omitting the Division:** Forgetting to divide the summed $x\, dA$ or $\sum A_i x_i$ by the total area. This yields a moment sum rather than the centroid coordinate. Always divide by the total area (or total length/volume) to get the average position.

- **Mixing Axes:** Mixing up x_c and y_c or using the wrong reference axis. Keep track of which direction each coordinate is measured. It helps to draw a clear sketch and coordinate system, marking each sub-area's centroid coordinates.

- **Unit Consistency:** Ensure all distances are in the same units when calculating x_c, y_c. The resulting centroid coordinates will have the same unit of length as the inputs (e.g. if dimensions are in mm, centroid comes out in mm).

- **Composite Shape Mistakes:** In composite shapes, be careful to use each part's centroid measured from the same global reference. A common error is using a part's local centroid coordinate instead of converting it to the overall reference frame.

Explanation & Analysis: Finding a centroid often involves breaking a shape into simpler parts and using the above formula in a step-by-step process. **For a composite area:** (1) Divide the shape into basic shapes (rectangles, triangles, etc.) for which centroids are known or easy to determine. (2) Set up a coordinate system and find each part's area A_i and centroid coordinates $(x_{c,i}, y_{c,i})$ relative to your reference axes. (3) Compute the first moments about each axis: $\sum A_i x_{c,i}$ and $\sum A_i y_{c,i}$. (4) Divide each moment sum by the total area $\sum A_i$. This yields $x_c = \frac{\sum A_i x_{c,i}}{\sum A_i}$ and $y_c = \frac{\sum A_i y_{c,i}}{\sum A_i}$. Always double-check that the centroid location makes sense (e.g. it should lie inside the boundaries for a uniform plate). For continuous shapes defined by functions, the integration formula serves the same purpose: it's essentially summing tiny slices. In practice, the FE Mechanical Exam usually provides or expects knowledge of standard centroid locations, so you won't often perform complicated integrals on exam day, but you must know how to apply the formulas or look up the values. A quick sanity check: if you compute a centroid for a simple shape like a right triangle and get $y_c = h/2$, you should recognize that as incorrect (it should be closer to the base at $h/3$) – catching such errors is easier if you visualize the shape and recall approximate centroid positions. Keep an intuitive feel: the centroid is the balance point, so more area on one side means the centroid shifts that way.

If the material is not of uniform density or thickness, the "centroid" of the shape alone isn't the center of mass. In such cases, weight each part by its mass (using $\bar{x} = \frac{\sum m_i x_i}{\sum m_i}$). For the FE exam, unless explicitly stated, assume uniform density so that geometric centroid and center of mass coincide.
It is possible for a centroid to lie outside the actual material (e.g. the centroid of a semicircular area lies above the flat base, in the air), but it should be collinear with known symmetry axes. Always confirm the direction of any offset (e.g. centroid of a semicircle is about 0.424 radius above the base line).

K06.T05.S02 – Area Moments of Inertia (Ix, Iy) and Composite Areas

Definition: The area moment of inertia (also called second moment of area) of a shape about an axis measures how spread out the area is from that axis. In practical terms, it indicates the shape's stiffness against bending about that axis. A larger moment of inertia means more area is located far from the axis, which increases resistance to bending (just as a deeper beam is stiffer).

Common Shapes: Standard formulas exist for I_x and I_y of common shapes (rectangles, triangles, circles, etc.). For example, a rectangle of width b and height h has $I_x = \frac{bh^3}{12}$ about an axis through its centroid (horizontal axis through its center) and $I_y = \frac{b^3 h}{12}$ about the vertical centroidal axis. These formulas allow quick calculation of second moments without doing integrals every time.

Composite Areas: For a composite area (built up from simpler shapes), the total moment of inertia about a given axis is the sum of each part's moment of inertia about that axis. If a component's centroid is not on the axis in question, you must shift its I from its own centroid to the target axis using the parallel-axis theorem (covered in the next subtopic). Essentially, $I_{\text{total}} = \sum(I_{\text{part about global axis}})$ – so we calculate each part's contribution about the global axis and add them.

Use in Design: Engineers use I to predict bending stress ($\sigma = \frac{My}{I}$) and deflection in beams, so it's a frequent figure in mechanical problems. A larger I (with the same material and cross-sectional area) means lower stress and deflection for a given load. Thus, understanding how to compute I helps in comparing cross-sections or designing reinforcements.

Units and Interpretation: The units of area moment of inertia are $length^4$ (e.g. m^4 in SI units). This comes from area (m^2) times distance squared (m^2), reflecting that I grows rapidly with the distance of area from the axis. A small change in shape dimensions can lead to a big change in I (for instance, doubling a beam's depth increases I_x by a factor of 8, since h is cubed).

Exam Handbook Search Cues (Not affiliated with or endorsed by NCEES): moment of inertia; second moment; area moment; I_x; I_y; composite inertia

Equation Passport – Second Moment of Area
Purpose: Quantifies the distribution of area relative to an axis, used to compute bending resistance and deflection (among other things).

Equations:

$$I_x = \int y^2\, dA, \qquad I_y = \int x^2\, dA$$

These define the second moment of area about the x-axis and y-axis respectively (through the reference origin). For composite shapes, a summation form applies: $I_{x,\text{total}} = \sum I_{x,i}$(about same axis).

Variables:

- I_x, I_y – Area moment of inertia about the x-axis or y-axis (units: m^4). The axis location must be specified (often through the centroid or at the object's base/edge).
- x, y – Distance from the y-axis (for I_y) or x-axis (for I_x) to the differential area element dA (m). In the integral, these distances are squared, emphasizing far-off areas.
- dA – Differential area element (m²); the integration (or summation) covers the entire area of the shape.
- (For composite sum: $I_{x,i}$ – the x-moment of inertia of part i about the global x-axis. If part i's centroid is not on that axis, use parallel-axis theorem to compute this from the part's centroidal inertia.)

Assumptions & Scope:

- Applies to rigid cross-sectional areas (planar areas); it's a purely geometric property. Material properties or forces are not part of I

itself (they come into play in stress formulas).
- The axis must be clearly defined. I_x and I_y will differ unless the shape is symmetric (e.g., for a square plate, $I_x = I_y$ about centroidal axes, but for a rectangle where $h \neq b$, $I_x \neq I_y$).
- Do not confuse **area** moment of inertia with **mass** moment of inertia (used in dynamics for rotating bodies). They share mathematical form but differ in units and physical meaning. Also, polar moment of inertia $J = I_x + I_y$ is used for rotation of areas (torsion of shafts) but in statics problems you usually stick to I_x or I_y unless asked for polar or radius of gyration.
- In the FE Mechanical Exam, you are often given or expected to recall I formulas for common shapes rather than derive them. You may need to compute the combined I for a built-up section (e.g., find I of a flange+web assembly).

Limit Checks:

- **Zero Area Limit:** If an area collapses into a line (imagine dA concentrated on the axis, so $y = 0$ for all area with respect to x-axis), then $I_x = \int 0^2 dA = 0$. A thinner distribution yields a much smaller inertia. This confirms that an axis through the centroid gives a minimum I – moving the axis away spreads distances and raises I.

- **Farther Distribution:** If you move a given area farther from the axis, I skyrockets (due to the $distance^2$ term). Doubling the distance of every area element from an axis will quadruple the moment of inertia. This sensitivity is why shapes like I-beams place material far from the neutral axis to maximize I.

- **Symmetry Check:** For a symmetric shape about the axis, the cross-product terms cancel (no xy term in these integrals), and it's valid to sum separate halves. If you get a non-zero I_{xy} for a symmetric shape, you likely misaligned axes or made an error. (Note: I_{xy} is the product of inertia, typically zero for shapes symmetric about x or y axes.)

Use vs. Related Concepts: Use the area moment formulas for calculating bending stiffness or combined section properties. When dealing with mass distribution in dynamics, use mass moments of inertia $I = \int r^2 dm$ (with density) instead. For torsional rigidity of circular shafts, the polar area moment $J = I_x + I_y$ is used, but for non-circular sections torsion is more complex (beyond FE scope). In summary, choose area I for structural/shape bending problems, and remember it's specific to the axis orientation.

Common Exam Traps:

- **Units Mix-Up:** Area moments of inertia have unusual units (e.g. in^4 or mm^4). A common mistake is to treat I as if it had units of $length^2$. Ensure you carry units properly: if dimensions are in inches, I comes out in in^4. If you need I in different units (say, to use with E in SI units), convert dimensions first or convert I appropriately at the end.

- **Wrong Axis Formula:** Using a centroidal formula when the problem asks for I about a different axis (like the base of a shape). For example, the formula $I_x = bh^3/12$ is for the centroidal horizontal axis of a rectangle. If the question wants I about the bottom of the rectangle, a common wrong step is to plug numbers into $bh^3/12$ directly. The correct approach is to adjust via parallel-axis theorem (which in this case would give $I_{\text{base}} = bh^3/3$). Always check which axis is referenced and adjust accordingly.

- **Ignoring Negative Areas:** For composite sections with cutouts or holes, forgetting to subtract the moment of inertia of the missing area (treating it as if area were still there). The proper method is to calculate I for the missing shape and subtract it from the total. Similarly, subtract its area when computing centroid if needed. Omitting this yields an overestimated inertia.

- **Arithmetic Errors Summing Components:** In composite inertia calculations, it's easy to make arithmetic mistakes when summing multiple contributions (especially if using parallel-axis shifts). Keeping a table of values (each part's A, I_{centroid}, distance d, and Ad^2) and summing systematically can help prevent errors.

- **Not Using Reference Data:** The FE exam provides many common I formulas. A trap is to attempt deriving an uncommon shape via integration during the exam, which wastes time and risks errors. Instead, use the exam handbook's table or decompose the shape into standard parts. Practice quickly locating the needed formula in the reference.

The **mass moment of inertia** $I = \int r^2 dm$ (units $kg \cdot m^2$ in SI) describes an object's resistance to angular acceleration (rotational inertia). The **area moment of inertia** (units m^4) instead relates to how an area's geometry resists bending. They are analogous mathematically (area A in one plays a similar role to mass m in the other), but they are not interchangeable. Make sure to use area properties for statics/structural problems and mass properties for dynamics problems.

K06.T05.S03 – Parallel-Axis Theorem (Transferring I to a Parallel Axis)

Purpose of Theorem: The parallel-axis theorem allows you to find the moment of inertia of a shape about any axis parallel to one through its centroid. It bridges the gap between a centroidal I (often given in tables) and an arbitrary axis I. This is essential for composite areas: you calculate each part's I about its own centroidal axes, then shift to the common reference axis to sum them up.

Theorem Statement: If I_c is the moment of inertia of an area about a centroidal axis, then the moment of inertia about a new axis parallel to that axis and a distance d away is $I_{\text{new}} = I_c + Ad^2$. The term Ad^2 accounts for the added inertia from moving the area's entire mass to be d away from the new axis. Importantly, d is the perpendicular distance between the centroidal axis and the new axis.

Implications: The farther an area is from the axis, the larger the Ad^2 term becomes – so moving an axis away from the centroid always increases the moment of inertia. This tells us the centroidal axis is the one with the minimum I for that shape. The theorem works in both directions: you can either add Ad^2 to shift outwards, or subtract Ad^2 to shift an axis inward (e.g., from a known base-axis I to the centroidal I, if needed).

Usage in Composites: To get the total I of a composite shape about some axis, calculate each component's I_c (about its own centroid axis parallel to the desired axis), then use $I_{\text{component about desired axis}} = I_{c,\, component} + A_{component} d^2$ (with d being how far the component's centroid is from the desired axis). Finally, sum up these adjusted I values for all parts. This systematic use of the parallel-axis theorem is often the only practical way to handle complex sections on the exam.

Also for Mass MOI: The same formula works for mass moments of inertia if you replace area A with mass m (or weight W/g). For example, to find the mass moment of inertia of a wheel about an axis offset from its center, you can take the centroidal mass moment and add md^2. In the FE Mechanical context, you'll mostly use this for area I, but it's good to remember the analogy.

Exam Handbook Search Cues (Not affiliated with or endorsed by NCEES): parallel axis; transfer inertia; $I = I_c + Ad^2$; composite inertia

Equation Passport – Parallel-Axis Theorem
Name & Purpose: *Parallel-Axis Theorem* – calculates the moment of inertia about an axis offset from the centroid by adding a correction term. It allows reuse of centroidal inertia values to get inertia about any parallel axis.

Formula:

$$I_{\text{offset}} = I_c + A\,d^2$$

Variables:

- I_c – Moment of inertia about the centroidal axis (m^4 for area inertia). This is often known from standard formulas or simpler calculation.
- I_{offset} – Moment of inertia about the new axis parallel to the centroidal one, offset by distance d (m^4). This is what we want to find.
- A – Area of the shape (m²). For mass moment applications, A would be replaced by mass m (kg).
- d – Perpendicular distance between the centroidal axis and the new axis (m). It's crucial that this is measured perpendicular to the axes since that's the direction of shift. Typically, $d = y_c$ or x_c of the shape if shifting to a horizontal or vertical line respectively.

Assumptions & Scope:

- The axes are parallel and never intersect. One axis passes through the shape's centroid, and the other is offset by distance d. The theorem does not apply for axes at an angle to each other (that requires a rotation transformation, not covered in statics basics).

- The entire area is considered to shift as a whole. The formula effectively treats the area as if it were concentrated at its centroid (hence Ad^2 is the moment of inertia of a point mass A at distance d). This is exact for computing the difference between the two axes' inertias.

- Valid for area moments and mass moments alike. In the exam context, you'll typically use this for planar areas; remember to use the proper A or m depending on the problem.

- Make sure d is measured correctly: it should be the shortest distance between the two axes (often a straight line perpendicular connecting them). Using an incorrect distance (like half the shape's width when the axes are horizontal lines separated vertically) is a common mistake.

Limit Checks:

- If $d = 0$ (the new axis is through the centroid), then $I_{\text{offset}} = I_c$. This makes sense: no offset means no change, as expected the formula gives the same inertia.

- As d increases, Ad^2 dominates. For a very large offset, $I_{\text{offset}} \gg I_c$. (For example, shifting a small area far from an axis yields a huge inertia, primarily from the Ad^2 term.)

- Because of the square, even a moderate offset can significantly raise I. If you calculate a shifted inertia and find it only slightly bigger than the centroidal I, double-check the distance and arithmetic – it might be larger than you expect. Conversely, if the centroidal I is much smaller than the Ad^2 term, that's normal for shapes where the reference axis is far from centroid.

Use vs. Sibling Methods: Use the parallel-axis theorem whenever you need I about a non-centroidal axis but know the centroidal I. It's far quicker than re-integrating or deriving from scratch. **Do not** use it for axes that are not parallel (for rotated axes in the plane, one would need the perpendicular-axis theorem or Mohr's circle for moments of inertia, which is beyond the FE's required scope). Also, don't confuse this with the perpendicular-axis theorem (which relates $I_x + I_y = I_z$ for flat plates in 2D). Parallel-axis is about shifting along a parallel direction, perpendicular-axis is about summing about orthogonal axes through the same point.

Common Pitfalls:

- **Wrong Distance (d):** A very frequent error is plugging in the wrong distance. Remember d is the distance between the two axes. For example, if you have a shape and want I about its base, d is the centroid's distance from the base (i.e. y_c if measuring vertical distance). Some students mistakenly use half the height or some other dimension without thinking – always locate the centroid first, then measure d.

- **Forgetting to Square:** The term is Ad^2, not Ad. Omitting the square (or accidentally not squaring the full distance in calculations) will drastically undercount the effect. Keep an eye on units: since A is m² and d^2 is m², Ad^2 yields m^4, matching the units of I. If you find yourself adding incompatible units, you've done something wrong.

- **Sign Confusion:** In the formula, d^2 is always positive, so $I_{\text{new}} = I_c + Ad^2$ always increases when moving away from centroid. You don't need to worry about sign (no negative signs here). If you're subtracting Ad^2 (for instance, going from a known base-axis I to find I_c, you'd do $I_c = I_{\text{base}} - Ad^2$), ensure the axis indeed lies between the centroid and the known axis so that subtraction makes sense. Subtracting when you should add (or vice versa) will give an unphysical result (like a centroidal I bigger than an outward axis I, which cannot happen).

- **Component Mix-ups in Composites:** When using the theorem for multiple parts, keep each part's area A and distance d separate. One trap is to mistakenly use the total area with an individual part's distance or some blended approach. The correct way is part-by-part: apply $I + Ad^2$ to each part individually, then sum. Mixing them up will yield nonsense. Organize your work clearly for each piece.

Explanation & Example: The parallel-axis theorem is best understood with a quick example. Suppose you have a rectangular area (width b, height h) and you know its centroidal moment of inertia about the horizontal axis through its center: $I_c = \frac{bh^3}{12}$. Now you want the moment of inertia about the base of the rectangle (along its bottom edge). Here the offset d is the vertical distance from the centroid to the base, which is $d = h/2$. Applying the theorem: $I_{\text{base}} = \frac{bh^3}{12} + (bh)\left(\frac{h}{2}\right)^2$. The second term $Ad^2 = bh \cdot$

$\frac{h^2}{4} = \frac{bh^3}{4}$. So $I_{\text{base}} = \frac{bh^3}{12} + \frac{bh^3}{4} = \frac{bh^3}{3}$. This matches the known direct formula for a rectangle about its base, confirming the theorem's result. In a composite scenario, imagine an L-shaped cross-section made of two rectangles. To find its I_x about the bottom, you would find each rectangle's I_x about its own centroid (easy from standard formulas), then shift each to the bottom axis with Ad^2 (using each rectangle's area and distance from its centroid to the bottom). Summing those gives the total I_x. This method is far cleaner than trying to integrate over the whole L-shape. On the FE exam, parallel-axis theorem is your friend whenever dealing with anything not already centered on the desired axis. Practice applying it step by step so you don't skip the crucial Ad^2 addition. Always verify that the shifted I you get is larger than the centroidal I – if not, recheck your work.

K06.T05.S04 – Using Standard Shape Tables for Centroids and Inertia

What Are Shape Tables? In the exam handbook (and many textbooks), you'll find tables of geometric properties for common shapes: rectangles, triangles, circles, semicircles, I-beams, etc. These tables list formulas for area, centroid coordinates, and moments of inertia about typical axes (often centroidal axes and base or edge axes). They are a gold mine for quickly answering exam questions without deriving everything from scratch.

Locating Data: The FE Mechanical exam handbook includes a "Statics" section with figures and tables of centroids and moments of inertia for basic shapes. Knowing how to quickly navigate or search this is critical. For instance, if the question involves a quarter-circle area, you might search the handbook for "centroid quarter circle" or go to the statics property tables and find the entry. The tables usually have diagrams defining dimensions (like base b, height h, radius r) – be sure to match these definitions to the shape in your problem.

Interpreting Table Entries: Each shape entry will specify the reference axes for the listed centroid coordinates and inertia values. For example, a triangle might list x_c from one leg and y_c from the base, and I_x about an axis through the centroid or base. Pay attention to notes like "about centroid" or "about base" in the table. If you need the value about a different parallel axis, you'll apply the parallel-axis theorem. Also, check if the table gives the polar moment J or radius of gyration r_g; sometimes these are included for convenience ($r_g = \sqrt{I/A}$). You likely won't need radius of gyration often for FE mechanical questions, but be aware it's just a derived quantity.

When to Use Tables: Ideally, use table values whenever you have a standard shape or a composite of standard shapes. For simple shapes (rectangle, circle), you might memorize key formulas, but for odd shapes (like a semicircle centroid location $= 4R/(3\pi)$ from the flat side), the table saves you from recall errors. On exam day under time pressure, it's faster to look up "semicircle centroid" than to derive it.

Combining Table Data: For composite shapes, you might need multiple table lookups. For instance, to get the centroid of a T-beam cross-section, use the table to get centroid locations of the flange and web rectangles. Then do the weighted average. Similarly, get each piece's I from the table (usually about their own centroidal axes), then shift and sum for the total I. The table provides the building blocks; you provide the assembly.

Exam Handbook Search Cues (Not affiliated with or endorsed by NCEES): rectangle centroid; triangle I_x; circle area properties; centroid table; radius of gyration

Table Passport – Reading Standard Shape Property Tables
Table Purpose: Provides quick lookup of centroids and area moments of inertia for standard shapes, eliminating the need for derivation during the exam. This helps in deciding where a resultant force acts or calculating section stiffness without error-prone calculations.

How to Read: Each row (or entry) corresponds to a shape with a defined diagram. Columns typically include: Area formula, centroid coordinates (x_c, y_c) with respect to the defined reference axes, and moment of inertia formulas about specified axes (often one set about centroidal axes and possibly another about base or edge axes). To use the table, identify the shape and orientation in your problem, match it to the table diagram, then plug your shape's dimensions into the formulas given. No interpolation is needed – these are exact formulas. Just be cautious to input the correct measurement for each variable (for instance, if the table uses b for base width and h for height, be clear which side of your shape is b).

Units and Data Source: All formulas assume a consistent unit system (plug dimensions in meters, get x_c in meters and I in m^4, for example). The table values are derived from classical geometry (and have been recompiled for this guide), not copied from any specific copyrighted source. They mirror what's found in engineering handbooks but are presented in a fresh way here.

Typical Exam Uses:

- **Centroid Location:** Determine where to place a resultant force. E.g., find the centroid of a composite area by looking up each part's centroid coordinates (from the table for rectangles, triangles, etc.) and then computing the weighted average.

- **Section Inertia:** Calculate a beam's I for bending stress. Often, you'll look up I_c for each part of a built-up cross-section (like flanges and webs from the table), then use the parallel-axis theorem to get their I about the common neutral axis, and sum them.

- **Selecting Shapes:** Occasionally a question might ask conceptually which shape (given same area) has larger moment of inertia about some axis – understanding table values helps here (e.g., a ring has more I than a disk of equal area because its area is farther out).

- **Sanity Checks:** Use known table values to verify calculations. If you compute a centroid or I by another method and have time, cross-check against the reference table's formula to catch mistakes.

Common Pitfalls:

- **Mismatched Axes:** Using a listed I about the wrong axis. For example, the table might give I_x about the centroidal horizontal axis, but your problem needs I about the bottom. You must either find if the table lists that (sometimes it does for simple shapes) or use $I_{\text{base}} = I_c + A(\text{depth}/2)^2$. Forgetting to do this conversion is a top source of error.

- **Confusing Dimensions:** Not all tables use the same notation. Ensure you know what each symbol means in that entry. For instance, one diagram's b might be the total width; another's r

might be radius. If you mix up radius vs diameter, or base vs height, the results will be wrong. Carefully re-sketch the shape with labeled dimensions to avoid confusion.

- **Unit Inconsistency:** When plugging into table formulas, maintain unit consistency. If the problem gave dimensions in mixed units (say inches and feet), convert them to one unit system before using the formulas. The table itself doesn't handle conversions. Many mistakes come from forgetting to convert, e.g., using $b = 12$ (inches) and $h = 3$ (feet) directly in a formula.

- **Sign or Orientation:** For centroid coordinates, be mindful of direction. Most tables assume coordinates from a particular corner or axis (often the left-bottom corner for areas in the first quadrant). If your reference is different (say you measure from the center or from the right side), you might need to adjust (for symmetric shapes, it might not matter, but for others it does). No negative coordinates are usually given in tables (they assume measurements within the shape bounds), so if your coordinate system is different, ensure you interpret properly.

- **Overlooking Special Cases:** Some shapes have symmetric centroids that are obvious (circle, square), but non-obvious inertias. Others have obvious inertias (like two identical rectangles side by side vs stacked – one has larger I_x, the other larger I_y). The table can clarify these, but if you only partially remember a formula, you might misapply it. Always double-check if unsure – the exam is not testing your memory of every formula, but your ability to find and use the right one.

Final Tip: In preparation, familiarize yourself with the layout of the exam handbook's statics section so you know where the shape property tables are. Practice a few problems where you quickly lookup a centroid or inertia – speed comes with familiarity. During the exam, when in doubt, it's safer to quickly check the reference than to rely on memory. Combining the table information with the parallel-axis theorem and the basic formulas will equip you to tackle virtually any centroid or moment of inertia question on the FE Mechanical. Good luck, and remember: visualize the shape, organize your data, and double-check units and axes for a smooth solution.

Topic 06 - Static Friction

Static friction is the force that keeps objects from sliding on contact surfaces. On exam day, you'll use Coulomb's dry friction model to decide if a block will stay put or start moving under a given load. Typical FE questions ask you to draw a free-body diagram, identify the normal force, and then compute whether the applied tangential force exceeds the frictional limit. In practice, static friction is like an invisible grip that increases with push until it *gives way*. Understanding this law helps you predict when motion just begins (impending motion) and when an object remains in equilibrium.

K06.T06.S01 – Coulomb's Model of Dry Friction (Static Friction)

Background: Surfaces in contact exert a frictional force that opposes impending slip. Static friction adjusts up to a maximum value. In Coulomb's model, this maximum (limiting) friction is proportional to the normal force pressing the surfaces together.

Key idea: If the applied force tries to move an object, static friction acts opposite that force **up to** a limit. Beyond that limit, the object *breaks loose* and starts to slide.

Behavior: When you slowly increase a push on a block, friction force grows to resist motion. Once you reach the threshold, any extra force causes sliding. (Think of it as a slope: the steeper you push, the more friction you need, until you can't push harder without sliding.)

Name and purpose: Coulomb's static friction law – predicts the maximum frictional force between dry surfaces, used to check equilibrium vs. impending slip.

Equation:

$$F \leq \mu_s N$$

This inequality says the frictional force F cannot exceed the product of the static friction coefficient μ_s and the normal force N. At *limiting equilibrium* (just before sliding), $F = \mu_s N$. This is the classic Coulomb criterion.

Variables & units:

- F: friction force (the tangential force resisting motion), in newtons (N) or pounds-force (lbf).
- μ_s: coefficient of static friction (unitless); depends on the pair of materials in contact.
- N: normal force (force pressing the surfaces together), in N or lbf. (E.g., on a horizontal surface N often equals the object's weight.)

Assumptions & scope:

- Surfaces are dry, rigid, and at rest (no relative motion yet).
- Friction is independent of contact area (only depends on N and μ_s).
- Valid for predicting the threshold of motion (impending slip) in statics problems.
- It ignores any motion after sliding starts (that would use kinetic friction instead).
- Temperature, lubrication, or wear effects are not included.

Limit tests (sanity checks):

- If $N = 0$ (no contact pressure), then maximum $F = 0$; without contact there's no friction.
- As $\mu_s \to 0$ (super-smooth surfaces), $F_{\max} \to 0$; basically no friction.
- As $\mu_s \to 1$ or larger, static friction can match or exceed the normal force, meaning very "sticky" surfaces.
- If an applied force exceeds $\mu_s N$, the object moves (the inequality cannot hold, indicating motion).

Use vs. kinetic friction: Apply $F \leq \mu_s N$ when surfaces are *not sliding*. If motion has already begun, switch to kinetic friction $F_k = \mu_k N$. In practice, $\mu_s > \mu_k$ for most material pairs (it usually takes more force to start moving than to keep moving).

Common exam traps:

- Forgetting that friction acts opposite the direction of *would-be* motion, not necessarily opposite a static applied force.
- Using μ_k (kinetic) instead of μ_s or vice versa.
- Assuming $F = \mu_s N$ always; that equality holds only at the limiting case.
- Mixing units (e.g. using μ_s with weight in lbm instead of lbf without the g_c factor).

Exam Handbook Search Cues (Not affiliated with or endorsed by NCEES): static friction, coefficient of static friction, limiting friction, normal force.

Footnotes:

- N here is *normal force*, not the unit Newton; be clear on units (N in N = newton or lbf in lbf).
- μ_s is dimensionless, typically between 0 (no friction) and ~1 or slightly above for very rough materials.
- The law holds up to impending motion; once sliding begins, this formula no longer applies.
- Often friction force F is treated as a magnitude in equations; its *direction* (opposite impending motion) is handled in the free-body setup.

Variations & related forms:

- **Limiting friction:** Often we use $F_{\max} = \mu_s N$ to compute the maximum static friction (when motion is about to start). Otherwise, for equilibrium, F can be less.
- **Angle of friction (φ):** Defined by $\mu_s = \tan\varphi$. The friction angle φ is the steepest incline angle at which an object just remains in equilibrium.
- **Example special case (incline):** A block on a slope with angle θ stays put if $\theta \leq \varphi$ (where $\tan\varphi = \mu_s$). If $\theta > \varphi$, it slides.
- **Kinetic friction note:** If movement starts, use $F = \mu_k N$ (kinetic). Typically μ_k appears in problems after motion begins.
- **Typical values:** Rough numbers (for general idea): wood-on-wood $\mu_s \approx 0.4$, rubber-on-concrete $\mu_s \approx 1.0$, steel-on-steel $\mu_s \approx 0.6$. (Always use the given or handbook values on the exam.)

Special Notes: When using a calculator, simply multiply μ_s by N. For example, on a Casio or TI calculator, enter mu_s * N (numeric values only). Calculators won't have a "μ" key; just substitute the

numeric value for μ_s. Make sure N is in consistent force units (e.g., if μ_s is unitless, and N is in newtons, the result is newtons).

Explanation & Analysis:

When you solve a statics problem with friction, start by drawing the free-body diagram and identifying the normal force N. For instance, on a horizontal floor N equals the object's weight (if no extra vertical loads). Next, compute the potential friction threshold: $F_{\max} = \mu_s N$. Now consider the applied tangential force (say a push or component of weight on an incline). If that applied force is **less than or equal to** $F_{\max}$, static friction can balance it and the object stays at rest. In that case, the actual friction force F simply equals the applied force (in magnitude) with opposite direction, ensuring $\sum F = 0$.

If the applied force exactly equals $F_{\max}$, the object is on the verge of sliding (impending motion). Here $F = \mu_s N$. If you exceed this, equilibrium breaks and motion occurs. On exam problems, check this condition: for example, if a 100 N push is applied on a block with $N = 200$ N and $\mu_s = 0.3$, then $F_{\max} = 0.3 \cdot 200 = 60$ N. Since 100 N > 60 N, the block would move (static equilibrium is not possible). If the push were only 50 N, then $F = 50$ N (the friction force) and the block remains stationary.

Physically, each symbol means:
- N is usually the sum of forces perpendicular to the surface (for a flat surface, $N = \text{weight} = mg$).
- μ_s comes from material properties; it has no units, so it only scales the magnitude of N.
- F is the actual frictional force needed to maintain equilibrium.

Keep track of signs: friction always opposes the direction an object *would* move. If your free-body sum of forces in the motion direction would be $+F_{\text{push}} - F = 0$, then F must be in the opposite sense of F_{push}. A common mistake is assuming friction direction incorrectly; always think "opposite impending motion". Also watch units: if weight is given in pounds-mass (lbm), convert to pounds-force (lbf) by using g_c or use consistent gravitational conversion.

In summary, use Coulomb's law as your criterion: **set up equilibrium with friction as an unknown** and check if the solution satisfies $F \le \mu_s N$. If it does, you're consistent; if it doesn't (you solve $\sum F = 0$ and get $F > \mu_s N$), then the block will actually move and the scenario changes. On the FE, you might be asked either for the maximum static friction or to decide if motion occurs – either way, this inequality is your key tool[1].

K06.T06.S02 – Belt Friction (Capstan Equation)

Concept: Friction between a belt (or rope) and a pulley allows one side to hold more tension than the other. Think of wrapping a rope around a pole: with each extra wrap, the rope "grips" harder. The *capstan equation* quantifies this by showing how the tension ratio grows exponentially with the wrap angle and friction coefficient.

Scenario: A belt or rope passes over a curved surface (pulley, capstan, drum) with total contact angle θ. One side (force F_1) is pulling toward impending motion, and the other side (F_2) resists. Static friction at the interface prevents slip until a critical ratio F_1/F_2 is reached.

Intuition: More wraps (larger θ) or rougher contact (higher μ) means a much bigger tension difference is possible. It's like making many loops around a post: even a gentle pull on one end can hold a heavy weight on the other.

Exam Handbook Search Cues (Not affiliated with or endorsed by NCEES): belt friction, capstan equation, contact angle, static friction

Equation Passport – Belt (Capstan) Friction: *relates tensions on a wrapped belt.*

Belt Friction (Capstan) Equation – $F_1 = F_2\, e^{\mu\theta}$.

- *Purpose:* Computes the maximum tight-side tension F_1 given a hold tension F_2, for a belt/rope wrapped by angle θ under static friction.
- *Alternate form:* Often written $F_1/F_2 = e^{\mu\theta}$. You can also solve for μ as $\mu = \frac{\ln(F_1/F_2)}{\theta}$ if needed.
- *Variables:*
- F_1 = tension on the pulling/driving side (force toward impending motion), [N or lbf].
- F_2 = tension on the resisting/holding side, [N or lbf].
- μ = coefficient of static friction (dimensionless).
- θ = total wrap (contact) angle in radians (see diagram below).
- *Assumptions:* Dry, Coulomb static friction; belt/rope is about to slip but not moving; uniform μ along contact; no belt elasticity effects. Valid for any rigid cylindrical contact (pulley, drum).
- *Limit tests:* If $\mu = 0$ or $\theta = 0$, then $e^{\mu\theta} = 1$ so $F_1 = F_2$ (no friction difference). As $\mu\theta \to \infty$, $F_1/F_2 \to \infty$ (infinitely large tension ratio – rope grips endlessly).
- *Use vs. similar formulas:* Use this instead of $F \le \mu N$ when dealing with a wrapped belt or rope on a pulley. For simple flat-surface problems, use $F \le \mu_s N$ (see static friction law).
- *Common traps:* Mixing up F_1 and F_2 (the larger tension must go in the correct place); forgetting to use radians for θ; using μ_k (kinetic friction) by mistake; dropping the e or exponent; working with gauge vs. absolute tensions.

Notes: Belt tension has units of force (N or lbf) on both sides. Ensure consistency (e.g. both in lbf or both in N). The coefficient μ is dimensionless. *Footnote:* In US customary units, both belt tensions are in lbf. If you work with mass in lbm or slugs, remember Newton's second law in USCS form: $F[\text{lbf}] = m[\text{lbm}]\, a[\text{ft/s}^2]/g_c$, where $g_c \approx 32.174$ lbm·ft/(lbf·s^2).

Variations & Typical Values:

- If solving for μ: $\mu = \ln(F_1/F_2)/\theta$. For example, if a rope wraps π radians (180°) and you need $F_1 = 2F_2$, then $\mu = \ln(2)/\pi \approx 0.22$.
- For partial wraps: the formula still holds with the given θ (e.g. $\theta = \pi/2$ rad for a 90° contact).
- Tension ratio example: With $\mu = 0.2$ and $\theta = \pi$ (half-turn), $F_1/F_2 = e^{0.2\pi} \approx e^{0.628} \approx 1.87$. So the tight side can be ~1.9× the slack side.
- If $\mu\theta$ is small (<0.3), $F_1 \approx F_2(1 + \mu\theta)$ (first-order Taylor). As a special check: if θ doubles, the exponent doubles, roughly squaring the ratio (since $e^{2x} = (e^x)^2$).

Calculator Tip: All allowed FE calculators can evaluate e^x. For example, on a Casio use the exp function, on HP use the e^x key, on TI use e^x (or $2nd$ ln). If computing $\mu = \ln(F_1/F_2)/\theta$, recall ln is the natural log. Double-check radian mode if using trig (though this formula itself doesn't use trig).

Explanation & Analysis

A belt or rope wrapped around a pulley can hold more load than a straight rope because each infinitesimal belt segment contributes frictional grip. The Capstan (belt friction) equation $F_1 = F_2 e^{\mu\theta}$ is derived by integrating the tiny friction forces around the wrap. In practice, this means the **tight side tension** F_1 (on the side trying to pull the belt) can exceed the **loose side tension** F_2 by a factor of $e^{\mu\theta}$. Use this whenever you have a pulley or drum and know the static friction coefficient between the belt and surface. For instance, an exam question might give μ and θ and ask for the maximum F_1 for a known F_2.

Now term-by-term: - F_1**:** The larger tension (force) on the side "pulling" toward motion. Unit: N (or lbf). Common mistake: labeling the wrong side. Remember *direction of impending motion* defines which side is F_1. Always put the larger (drive) force as F_1 in the formula.

- F_2**:** The smaller tension holding back motion. Unit: same as F_1. If F_2 is known (like the weight or slack tension), you solve for F_1. If you need the opposite, you can rearrange the formula.

- μ**:** Coefficient of static friction (no unit). Typical exam values might be 0.1–0.3 for rubber on metal, 0.15 for rope on drum, etc. *Pitfall:* Don't plug in μ_k (which is for sliding) when the belt is stationary (impending slip).

- θ**:** Wrap angle in **radians**. If the belt wraps halfway (180°), then $\theta = \pi$ rad. *Always convert degrees to radians!* A common error is to leave θ in degrees.

- **Exponential behavior:** The factor $e^{\mu\theta}$ grows quickly with $\mu\theta$. For small $\mu\theta$, you can approximate $e^{\mu\theta} \approx 1 + \mu\theta$. For large $\mu\theta$, the ratio can become huge (e.g. doubling θ roughly squares F_1/F_2). As a sanity check, if $\mu\theta = 0$ then $F_1 = F_2$. If someone claims $F_1 < F_2$ using this formula, they likely put the sides backward.

Quick check: Suppose you had no friction ($\mu = 0$) or the belt didn't wrap at all ($\theta = 0$); then $e^0 = 1$ and the tensions must be equal, as expected. On the other extreme, if the belt wraps fully around ($\theta = 2\pi$) with high μ, F_1 can be many times F_2.

In summary, to use the capstan equation, identify the driving and resisting tensions, measure the wrap angle in radians, and plug in the static friction coefficient. Solve for whichever unknown (usually F_1 or μ). Keep track of units (both F_1 and F_2 in lbf or N) and remember ln and e^x behavior. If you reverse which side is "driving," the equation becomes $F_2 = F_1 e^{\mu\theta}$ – essentially swapping roles.

Sources: Belt friction formula as given in the exam handbook[1] (capstan equation, static case). Static friction law $F \le \mu_s N$[2] underlies the derivation of this result.

K06.T06.S03 – Threaded Screw Friction (Power Screw Torque)

Principles (conceptual):

- A power screw converts rotational torque into an axial force. You can model the helical thread as an inclined plane wrapped around the screw. The **pitch angle** α is given by $\tan\alpha = \frac{l}{\pi d_m}$, where l is the lead and d_m is the mean thread diameter.
- Friction on the threads and on the collar both resist motion. Thread friction acts along the helical surface (angle α), while collar friction acts at radius $d_c/2$ under the load.
- There are two cases: **raising** (tightening) and **lowering** (loosening). The torque required to raise the load, T_R, is always higher than for lowering, T_L, because friction adds differently.

Equation Passport – Power Screw Torque (Square Thread): Torque required on a square-thread power screw to *slowly* raise or lower an axial load, including friction on both the threads and the collar (thrust bearing).

Equations (raise vs. lower, including collar friction):

$$T_R = \frac{F d_m}{2}\,\frac{l + \pi\mu d_m}{\pi d_m - \mu l} + \frac{F\mu_c d_c}{2}$$

$$T_L = \frac{F d_m}{2}\,\frac{l - \pi\mu d_m}{\pi d_m + \mu l} + \frac{F\mu_c d_c}{2}$$

where

- T_R is the torque applied in the *raising* (tightening) sense.
- T_L is the torque applied in the *lowering* (loosening) sense using the same sign convention; a negative T_L from the formula indicates the screw is self-locking (the load will not run down on its own).

(If you prefer to think in angles, set $\tan\lambda = \frac{l}{\pi d_m}$. Then the thread-only part is
$T_R = \frac{F d_m}{2}\frac{\tan\lambda + \mu}{1 - \mu\tan\lambda}$,
$T_L = \frac{F d_m}{2}\frac{\tan\lambda - \mu}{1 + \mu\tan\lambda}$,
and the collar term $F\mu_c d_c/2$ is simply added to each.)

Variables and Units:

T_R, T_L– Algebraic torque about the screw axis for raising (R) and lowering (L) (N·m or ft·lb). Positive direction is whichever you choose as "raise"; T_L may come out negative if the screw would over-haul.

F– Axial load carried by the screw (N or lbf).

d_m– Mean (pitch) diameter of the thread (m or ft). For a square thread you can often approximate $d_m \approx d_o - \frac{p}{2}$ where d_o is outside diameter and p is pitch.

l– Lead of the screw (m or ft): axial advance per full revolution. For a single-start thread, $l = p$; for an n-start thread, $l = np$.

μ– Coefficient of friction on the thread surface (dimensionless).

d_c– Effective (mean) collar diameter where the load reacts (m or ft).

μ_c– Collar friction coefficient (dimensionless) at the thrust interface.

Assumptions/Scope:

- Square (or close to square) power screw, slowly loaded → **static** friction applies (no dynamic effects, no impact).

- Axial load F is essentially constant over a revolution and acts along the screw axis.

- The screw behaves as a rigid body; bending, misalignment, and elastic deformation are ignored.

- Friction coefficients μ and μ_c are taken as known constants for the contact pair and lubrication state.

- Units are consistent: all lengths in the same units; all forces in the same units → torque comes out as force × length (N·m, ft·lb, in·lb, etc.).

Limit tests:

Frictionless screw (ideal): If $\mu = 0$ and $\mu_c = 0$, both torque formulas collapse to

$$T_R = T_L = \frac{Fl}{2\pi}$$

which is just "force × lead / (2π)", the geometric torque with no losses.

Very fine thread (small lead): As $l \to 0$, the thread acts almost like a vertical sliding surface:

$$T_R \to \frac{Fd_m\mu}{2} + \frac{F\mu_c d_c}{2}$$
$$T_L \to -\frac{Fd_m\mu}{2} + \frac{F\mu_c d_c}{2}$$

The first term is the torque to overcome thread friction; sign flip in T_L reflects that friction always opposes motion.

Self-locking condition (no "run-down"):
The sign of T_L comes from the factor $(l - \pi\mu d_m)$.

- If $l < \pi\mu d_m$ (equivalently $\tan\ \lambda < \mu$), then $T_L < 0$. The screw is *self-locking*: the load will not descend by itself, and you must apply torque in the **raising** sense to lower it.
- If $l > \pi\mu d_m$, $T_L > 0$: the screw is "over-hauling" and the load tends to drive the screw unless restrained.

Use vs. sibling equations:

Use these **power-screw** formulas when the problem gives actual dimensions of the screw (d_o, p, d_c) and specific friction coefficients for threads and collar. hese are the standard square-thread power screw relations you'll also see in common machine-design texts and in the FE handbook, with the collar-friction term written explicitly.

The simpler screw-thread relation $M = Pr\tan\ (\alpha \pm \phi)$ (no collar, expressed in terms of pitch angle α and friction angle ϕ) is a special case: it is equivalent to the thread-portion of the formulas above with $r = d_m/2$, $\tan\ \alpha = l/(\pi d_m)$, and $\tan\ \phi = \mu$.

If collar friction is negligible, set $\mu_c = 0$ and drop the $F\mu_c d_c/2$ term.

Common pitfalls:

Mixing diameters: Confusing mean thread diameter d_m with outside diameter d_o. If the FE problem gives d_o and pitch p, compute or be given d_m; do *not* simply plug d_o into the formulas.

Pitch vs. lead: For multi-start screws, $l = np$. Using p instead of l underestimates torque by a factor equal to the number of starts.

Forgetting the denominator: The $(\pi d_m \mp \mu l)$ terms matter. Dropping them turns the expression into a crude approximation and can change the answer significantly when friction is not tiny.

Ignoring collar friction: On some FE questions, the collar contribution $F\mu_c d_c/2$ is a substantial part of the total torque. If the statement mentions a thrust bearing or collar diameter and μ_c, it's a hint that this term must be included.

Sign interpretation: Treat T_R and T_L as algebraic torques. If the computed T_L is negative, that flags a self-locking screw; the *magnitude* of torque you must supply to actually lower the load is then $|\ T_L\ |$, applied in the raising direction.

Exam Handbook Search Cues (Not affiliated with or endorsed by NCEES): *power screw*, *raise torque*, *lower torque*, *mean diameter*, *lead of screw*, *collar friction*, *thread friction coefficient*. These are key phrases to search in the exam handbook for this topic.

Footnotes (subtle points):

- *Units:* If using U.S. customary units (lbf, in), include the gravitational constant $g_c = 32.174$ lbm·ft/(lbf·s²) consistently. In SI, simply N·m.

- *Friction Angles:* The friction coefficients can be expressed as angles: $\tan\phi = \mu$, $\tan\phi_c = \mu_c$. Sometimes it's easier to compute $\phi = \arctan\mu$.

- *Multi-start screws:* For an n-start thread, use $l = np$ (lead equals number of starts times pitch). Double-check whether the problem already gives the lead.

- *Self-locking:* If T_L from the formula is negative or zero, the screw is self-locking (it won't back-drive without external torque). In that case, *lowering* requires applying torque *in the same direction* as raising (not reversing direction).

- *Sign conventions:* We treat T_R and T_L as magnitudes. The "±" in handbooks can be confusing—just remember "+" with μ for raising and "–" for lowering when using the main formula above.

Variations & Typical Values:

No collar: If the collar is negligible or effectively frictionless, set $\mu_c = 0$. In practice that just means *drop the collar term* $+\frac{1}{2}F\mu_c d_c$ from both torque formulas and keep only the thread-friction part.

Small friction: If μ and μ_c are both very small (well-lubricated screw and thrust surface), then

$$T_R \approx T_L \approx \frac{F\,l}{2\pi},$$

which is the "ideal" frictionless screw torque.

Efficient screws: Screw efficiency in raising is

$$\eta = \frac{F\,l}{2\pi\,T_R},$$

i.e., ideal torque over actual raising torque. In practice ηoften falls somewhere around 20–80% (ball screws near the high end; rough, dry power screws toward the low end).

Typical numbers: For a steel power screw, thread friction $\mu$is often around 0.1–0.2. Lead angles $\alpha$are usually small (a few degrees for fine threads), so $\tan\ \alpha = l/(\pi d_m)$is a small number. A collar might have $\mu_c \approx 0.05$–0.1. Under moderate loads, the collar term can easily contribute on the order of 10–20% of the total torque.

Special Notes (calculators):

On FE-approved calculators (Casio fx-115/991, HP 33s/35s, TI-30X/36X), the main danger is losing track of the nested fractions. A safe sequence is:

1. Compute the dimensionless helix factor $\lambda = \frac{l}{\pi d_m}$.
2. For *raising*, form the thread factor $B_R = \frac{\lambda+\mu}{1-\mu\,\lambda}$.
3. For *lowering*, form $B_L = \frac{\lambda-\mu}{1+\mu\,\lambda}$.
4. Then compute $T_R = \frac{F d_m}{2}\ B_R + \frac{1}{2} F \mu_c d_c, T_L = \frac{F d_m}{2}\ B_L + \frac{1}{2} F \mu_c d_c$.

Example keystroke pattern for raising torque (pseudo-code):

```
lambda = l/(pi*d_m)
T_R = F*d_m/2 * ((lambda + mu)/(1 - mu*lambda)) +
0.5*F*mu_c*d_c
```

If you prefer to think in angles, you can still use $\tan\ \alpha = l/(\pi d_m)$and $\tan\ \phi = \mu$; the same expressions pop out after you apply $\tan\ (\alpha \pm \phi)$.

Explanation & Analysis (step-by-step):

1- **Model the screw.** Draw the free-body diagram: the axial load Facts along the screw axis; the threads and collar provide reactions. Mark the mean thread diameter d_m, collar diameter d_c, pitch p, and lead l. (For a single-start thread, $l = p$; for an n-start thread, $l = np$.)

2- **Compute the lead angle α.** Over one turn, the thread advances axially by $l$while wrapping once around the mean circumference πd_m. That gives

$$\tan\ \alpha = \frac{l}{\pi d_m}.$$

A smaller $l$or larger $d_m$means a shallower helix and more mechanical advantage (less torque for the same load).

3- **Apply equilibrium with friction.** Conceptually "unwrap" one thread turn into an inclined plane. The pitch angle is α, and friction is represented by a friction angle $\phi$with $\tan\ \phi = \mu$. The standard screw-equilibrium relation can be written as

$$T_{\text{thread}} = F\left(\frac{d_m}{2}\right)\tan\,(\alpha \pm \phi),$$

where "+" is for raising (friction opposing uplift) and "−" is for lowering. Replacing $\tan\alpha$and $\tan\phi$with $l/(\pi d_m)$and μ, and simplifying $\tan\,(\alpha \pm \phi)$, yields the $(\lambda \pm \mu)/(1 \mp \mu\lambda)$factors used in the passport formulas. Collar friction simply adds an extra torque $F\mu_c(d_c/2)$resisting motion in either direction.

4- **Interpret each term.**

- The factor $Fl/(2\pi)$inside the algebra is the "ideal" torque with no thread friction at all.
- The bracket $(\lambda \pm \mu)/(1 \mp \mu\lambda)$modifies that ideal value to account for thread friction: for raising, friction increases the required torque; for lowering, friction reduces the torque needed and can even reverse its sign if friction is large enough.
- The collar term $\frac{1}{2}F\mu_c d_c$is purely from sliding at the thrust face and always resists motion.

5- **Compute and check.** Plug in the numbers (consistent units!) and compute $T_R$and T_L. Quick sanity checks:

- Typically $T_R > T_L$.
- If your computed $T_L$comes out negative, that indicates a **self-locking** screw: the load will not run down on its own; you would have to apply torque in the "raising" sense even to lower the load.

6- **Avoid common errors.**

- Don't mix up d_m(mean thread diameter) with d_c(collar diameter) or with the outside screw diameter.
- Keep $\mu$and $\mu_c$dimensionless (if given in %, convert to decimals).
- Use the correct signs in the thread factor: "$+\mu$ over $1 - \mu\lambda$" for raising, "$-\mu$ over $1 + \mu\lambda$" for lowering.
- Remember that we normally report **magnitudes** for $T_R$and T_L; if you carry the sign through, a negative $T_L$is interpreted as the self-locking case described above.

DON'T MOVE ON YET!

Work Through Some Solid Practice Problems
while the Material of this Knowledge Is Still Fresh
THIS IS HOW THE CONCEPTS LOCK IN.

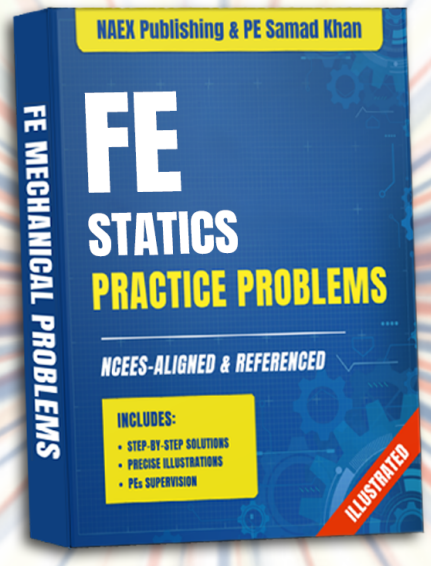

CLICK HERE TO PRACTICE

You'll be taken to our Discord Server,
where the problems are located.

KNOWLEDGE 07

DYNAMICS, KINEMATICS, AND VIBRATIONS

- NAEX Publishing -

"This publication is not affiliated with or endorsed by NCEES".

.

Topic 01- Kinematics of Particles

Topic Overview: Kinematics of particles is the study of how a particle (an object treated as a point mass) moves – described by its **displacement**, **velocity**, and **acceleration** as functions of time – without directly considering the forces causing the motion. This topic is fundamental for the FE Mechanical Exam because it lays the groundwork for solving dynamics problems: you often first need to determine accelerations or velocities using kinematics before applying Newton's laws or energy methods. On exam day, expect questions where you must *predict motion outcomes* (how far, how fast, how long?) given initial conditions and accelerations. Common scenarios include **projectile motion** (objects launched through the air), **circular motion** (objects moving in loops or turns), and **relative motion** (objects observed from moving reference frames). Mastering particle kinematics means you can confidently break down motion into components, apply the right equations for position and velocity over time, and avoid pitfalls with units and directions. In the context of the FE exam specification, this is part of Knowledge Area 07 "Dynamics, Kinematics, and Vibrations," typically contributing a few questions to the exam's total. Below, we'll cover each key subtopic – with principles, formulas, and problem-solving tips – to ensure you're exam-ready for particle kinematics.

K07.T01.S01 – Kinematic Quantities for Particle Motion: Displacement, Velocity, Acceleration (Functions of Time)

- **Displacement (r):** A vector from a reference point (origin) to the particle's position. It represents *where* the particle is located in space. As a function of time $\mathbf{r}(t)$, it can be described by coordinates (e.g. $x(t)$ in 1D, or $x(t), y(t), z(t)$ in 3D).
- **Velocity (v):** The time rate of change of displacement – in other words, how fast and in what direction the particle's position is changing. It is the *derivative* of position with respect to time. Velocity is a vector, and its magnitude is the **speed**.
- **Acceleration (a):** The time rate of change of velocity. It tells us how the velocity is changing – speeding up, slowing down, or changing direction. Acceleration is the rate of change of velocity with time (equivalently, the second derivative of displacement with respect to time). Like velocity, it's a vector.
- **Instantaneous vs. Average:** *Instantaneous* velocity/acceleration are given by derivatives at a specific moment. *Average* velocity/acceleration over a time interval $\Delta\, t$ are given by ratios $\Delta\, \mathbf{r}/\Delta\, t$ or $\Delta\, \mathbf{v}/\Delta\, t$. On the FE, we usually deal with instantaneous quantities (unless a problem explicitly asks for an average over a time span).
- **Units and Sign Conventions:** Displacement is measured in length units (m, ft). Velocity in length per time (m/s, ft/s). Acceleration in length per time squared (m/s², ft/s²). Direction matters: by choosing a coordinate system (axes), positive or negative signs will indicate direction along those axes. It's crucial to stick to a consistent unit system and sign convention (e.g. if upward is positive, then gravity gives a negative acceleration).

Exam Handbook Search Cues (Not affiliated with or endorsed by NCEES): *kinematics, displacement, velocity, acceleration, position vector, time derivative*

Footnotes:

- *Dimensions:* Displacement is a length (L). Velocity is L/T. Acceleration is L/T². Be vigilant converting units (e.g. if using ft and s, acceleration due to gravity is about 32.174 ft/s^2; in m and s, 9.81 m/s^2).

- *Vector notation:* A boldface **v** or arrow $\vec{v}$ indicates a vector quantity. On the exam, vectors might be given in component form, e.g. v_x and v_y.

- *Sign vs Direction:* A negative velocity doesn't mean "slower" – it means motion opposite to the defined positive direction. Similarly, negative acceleration can indicate slowing down *if* velocity is positive, or speeding up in the negative direction.

Variations and Related Forms:

- Average velocity $\bar{\mathbf{v}} = \frac{\Delta\, \mathbf{r}}{\Delta\, t}$ and average acceleration $\bar{\mathbf{a}} = \frac{\Delta\, \mathbf{v}}{\Delta\, t}$ are useful for uniform or piecewise-constant motion. If acceleration is constant (a common exam assumption in segments of motion), the relationship between s, v, a, and t simplifies to the **constant acceleration equations** (covered later in subtopic K07.T01.S04).
- In circular motion or oscillatory motion, acceleration can be nonzero even when speed is constant (acceleration then changes direction but not magnitude). In straight-line (rectilinear) motion, velocity and acceleration can be treated algebraically with sign indicating direction.

Equation Passport: Velocity and Acceleration (Definitions) – computes instantaneous velocity and acceleration from position or velocity as functions of time.

- **Equation:** $\mathbf{v}(t) = \frac{d\mathbf{r}(t)}{dt}, \quad \mathbf{a}(t) = \frac{d\mathbf{v}(t)}{dt} = \frac{d^2\mathbf{r}(t)}{dt^2}$

- **Variables:** $\mathbf{r}(t)$ = position vector of the particle as a function of time (m or ft); t = time (s); $\mathbf{v}(t)$ = velocity (m/s or ft/s); $\mathbf{a}(t)$ = acceleration (m/s² or ft/s²). Each of these can be expressed in components along chosen axes (e.g., $x(t)$, $y(t)$ for position).

- **Assumptions:** These definitions assume a continuous, differentiable motion – the particle's position changes smoothly so that a velocity at each instant exists. The particle is treated as a point (no rotation or size concerns). These equations are valid in any inertial reference frame (one that's not accelerating or rotating relative to "fixed" stars/Earth for exam purposes).

- **Limit checks:** If the particle is stationary (no change in position), $d\mathbf{r}/dt = 0$ so $\mathbf{v} = 0$ and consequently $\mathbf{a} = 0$. If the particle moves with constant velocity (no change in **v**), then $d\mathbf{v}/dt = 0$ so $\mathbf{a} = 0$. These edge cases make physical sense (zero acceleration means constant velocity; zero velocity means no displacement change).

- **Use vs. siblings:** Use these instantaneous definitions to derive other kinematic formulas or when given a functional form of motion (e.g., $x(t)$ explicitly). For average rates over a time interval $\Delta\, t$, use $\bar{v} = \Delta\, \mathbf{r}/\Delta\, t$ and $\bar{a} = \Delta\, \mathbf{v}/\Delta\, t$ instead – but remember, average values are only equal to instantaneous values if acceleration is constant.

- **Common exam traps:** (1) Mixing up $\mathbf{v}$ and $\mathbf{a}$. For example, given $x(t)$, a common mistake is to plug into $x = vt + \frac{1}{2}at^2$ (constant acceleration formula) directly without identifying which quantity is which. Always differentiate position to get velocity, and velocity to get acceleration. (2) Forgetting direction: an answer that's just a positive number without direction (when direction matters) may be incomplete or wrong. (3) Unit mix-ups, especially when converting (e.g., using $g = 9.81$ in an equation where units are in feet, or time given in minutes but velocity in m/s). Always check that time units match and that you've applied any unit conversion constants if needed (the exam expects you to catch these).

Explanation: In essence, displacement, velocity, and acceleration describe *how a particle moves*. Displacement $\mathbf{r}(t)$ tells you *where* the particle is at time t. Velocity $\mathbf{v}(t)$ tells you *how fast and in what direction* the particle is moving at time t – think of it as the speedometer reading with a direction arrow. Acceleration $\mathbf{a}(t)$ tells you *how the velocity is changing* – like what a car's accelerator or brake is doing to the speed, and in what direction the change is happening. On the FE Mechanical Exam, you might start with these basic definitions in problems that ask for things like velocity given a position function, or acceleration given a velocity-time graph. Remember that these kinematic quantities are often intermediate steps: for example, you may need to find acceleration from a velocity function in order to then plug into Newton's Second Law ($F = ma$) in a dynamics problem. Understanding the calculus definition is important, but equally important is knowing the *interpretation*: If $\mathbf{a} = 0$, the particle moves with constant velocity (straight-line, uniform motion). If $\mathbf{a}$ is opposite to $\mathbf{v}$, the particle is slowing down. If $\mathbf{a}$ is perpendicular to $\mathbf{v}$, the particle is turning (changing direction but not speed). Being comfortable with these concepts will help you reason through problems even if you momentarily forget a formula – you can derive it from knowing these fundamental relationships.

Analysis: Let's break down $\mathbf{v}(t) = d\mathbf{r}/dt$ component-wise. If $\mathbf{r}(t) = x(t)\mathbf{i} + y(t)\mathbf{j} + z(t)\mathbf{k}$ in a 3D Cartesian coordinate system (using $\mathbf{i}, \mathbf{j}, \mathbf{k}$ as unit vectors along x, y, z axes), then differentiating gives $\mathbf{v}(t) = \dot{x}(t)\mathbf{i} + \dot{y}(t)\mathbf{j} + \dot{z}(t)\mathbf{k}$, where $\dot{x}(t) = dx/dt$ is the x-component of velocity (and similarly for y, z). Differentiating again, the acceleration is $\mathbf{a}(t) = \ddot{x}(t)\mathbf{i} + \ddot{y}(t)\mathbf{j} + \ddot{z}(t)\mathbf{k}$ (double dots denoting second derivatives). Each component equation — $\dot{x}(t) = v_x(t), \dot{y}(t) = v_y(t), \dot{z}(t) = v_z(t)$ — means the rate of change in each independent direction. This matters for problem-solving: you can work with each dimension separately. For example, in projectile motion (2D motion under gravity), we often set up $x(t)$ and $y(t)$ equations independently. The main idea is that **velocity corresponds to the slope of a position–time graph**, and acceleration corresponds to the slope of a velocity–time graph. If you have a graph given, you might need to interpret slope or area under curves (since the integral of acceleration gives velocity change, etc.). Always double-check which quantity a problem is asking for: it might give you acceleration as a function of time and ask for velocity (requiring integration), or give a position function and ask for acceleration (requiring two derivatives). Practicing these derivatives and integrals ahead of time will build your intuition. One practical tip: if you are ever unsure, carry the units through your calculation – they can tell you if you accidentally differentiated when you should have integrated. For instance, differentiating position (m) gives velocity (m/s); differentiating again gives acceleration (m/s²). If you integrate acceleration (m/s²) over time (s), you get velocity (m/s). Keeping track in this way can prevent mistakes on exam day.

K07.T01.S02 – Motion in Cartesian (Rectangular) Coordinates (e.g. Projectile Motion)

- **Independence of Perpendicular Directions:** In Cartesian coordinates (usually using x, y, z axes at right angles), motion along each axis is independent. This means you can treat the horizontal and vertical motions separately and then combine them to get the full trajectory. For example, in projectile motion (an object launched into the air with some initial velocity), the horizontal motion (along x) and vertical motion (along y) are analyzed with separate equations.
- **Horizontal Motion (Constant Velocity):** If no force acts horizontally (no air resistance, etc.), the horizontal acceleration $a_x = 0$. So horizontal velocity v_x remains constant throughout the flight. The horizontal position changes linearly with time: $x(t) = x_0 + v_{0x}\,t$, where v_{0x} is the initial velocity component in the x-direction.
- **Vertical Motion (Constant Acceleration):** Under uniform gravity (and no other vertical forces), vertical acceleration a_y is constant (downward $= -g$, where $g \approx 9.81\ \mathrm{m/s^2}$ or $32.17\ \mathrm{ft/s^2}$). The vertical motion is uniformly accelerated motion. Equations like $y(t) = y_0 + v_{0y}t - \frac{1}{2}gt^2$ and $v_y(t) = v_{0y} - g\,t$ apply (taking upward as positive, for instance).
- **Projectile Motion Archetype:** A common exam-style scenario is: a projectile launched at speed v_0 at angle θ above horizontal. You split the initial velocity into components: $v_{0x} = v_0\cos\theta, v_{0y} = v_0\sin\theta$. Then apply the above separate motions: horizontal travels at v_{0x} constant, vertical starts at v_{0y} and accelerates downward at g. The trajectory forms a parabola. Key outcomes like **time of flight**, **range**, **maximum height** can be found from these equations.
- **3-D or 2-D Cartesian:** Most problems are planar (2D) so you'll use x and y. In some cases, you might see z (vertical) used instead of y. If 3D, just remember each direction is still independent (e.g. projectile fired with an initial velocity vector in 3D still has each component handled separately).
- **Choosing Axes:** A smart choice of coordinate axes can simplify a problem. For instance, in an inclined plane problem, you might align one axis along the incline. But for pure projectile motion in free space, it's typical to use horizontal x and vertical y. Just be consistent: if you define up as $+y$, then acceleration due to gravity is $-g\,\mathbf{j}$.

Exam Handbook Search Cues (Not affiliated with or endorsed by NCEES): *projectile motion, horizontal range, trajectory, x(t), y(t), constant acceleration*

Footnotes:

- *Gravity direction:* On the exam, the problem statement usually implies a coordinate choice (e.g. "upward is positive" or simply by context). If not explicitly stated, you can assume upward as positive y for projectile problems – just remember to put g as negative in equations ($-9.81\ \mathrm{m/s^2}$) for the vertical acceleration.

- *Units:* Make sure to use consistent units. A common mistake is mixing feet and meters or degrees and radians. For example, if range is asked in feet but you use $g = 9.81\ \mathrm{m/s^2}$, you'll be off by a factor. And if an angle is given in degrees, your calculator should be in degree mode when computing sine and cosine for initial components.

- *Neglect air resistance:* Unless stated otherwise, projectile motion problems assume no air drag. That's why $a_x = 0$. If a problem does include a resistive force, it's beyond simple closed-form equations and will be clearly indicated (rare for FE exam).

Variations and Special Cases:

- **Horizontal Launch:** If a projectile is launched purely horizontally ($\theta = 0$), then $v_{0y} = 0$. The motion simplifies: $x(t) = v_0 t$, $y(t) = y_0 - \frac{1}{2}gt^2$. This often models objects thrown off a cliff or table. The range in horizontal launch is easy: $x_{\text{range}} = v_0\, t_{\text{flight}}$ where t_{flight} comes from vertical drop time.

- **General Launch from Elevated/Depressed Points:** If launch and landing heights differ, the time-of-flight formula and range formula need the quadratic formula. You can always rely on the equations rather than memorizing a one-size formula: solve $y(t_{\text{landing}}) = y_{\text{land}}$ (a quadratic in t) to get flight time, then plug into $x(t)$.

- **Typical Values:** In the absence of air resistance, the optimal angle for maximum range on level ground is 45°. That might not be directly asked, but it's a good check: e.g., if you get an angle like 50° giving a longer range than 40° for the same speed, it makes sense (45 is best, so 50 vs 40, 40 should give slightly less range than 45, and 50 similarly). Knowing this can serve as a quick sanity check for your calculations.

Equation Passport: Constant Acceleration in 1D (Cartesian) – applies to each coordinate (e.g. treat horizontal and vertical separately) when acceleration is constant.

- **Name and purpose:** *Kinematic Equations for Uniform Acceleration* – predict displacement and velocity as functions of time (or related by eliminating time) when acceleration a is constant. Especially useful for projectile motion (vertical motion under gravity is constant $-g$) and other rectilinear motions with constant acceleration.

- **Equations:** For a given axis (say x-direction) with constant acceleration a_x:

1. $v_x(t) = v_{0x} + a_x t$ – **velocity-time relation**.
2. $x(t) = x_0 + v_{0x} t + \frac{1}{2}a_x t^2$ – **displacement-time relation**.
3. $v_x^2 = v_{0x}^2 + 2a_x (x - x_0)$ – **velocity-displacement relation** (time eliminated).

(Here x_0 and v_{0x} are initial position and initial velocity component at $t = 0$.)

- **Variables:** x = position at time t (m or ft); x_0 = initial position (m or ft); v_x = velocity component at time t (m/s or ft/s); v_{0x} = initial velocity component (m/s or ft/s); a_x = constant acceleration in the x-direction (m/s² or ft/s²); t = time (s).

- **Assumptions:** Acceleration a_x is constant in magnitude and direction during the time interval of interest. This is true for gravity near Earth's surface (taking g constant), or any motion under a constant net force. The motion is along a straight line (1D along the axis considered). Also assumes a start time $t = 0$ at which initial conditions x_0, v_{0x} are known.

- **Limit checks:** If $a_x = 0$ (zero acceleration, i.e. constant velocity motion), these equations reduce correctly: $v_x(t) = v_{0x}$ (no change in velocity), and $x(t) = x_0 + v_{0x}t$ (linear motion). If $v_{0x} = 0$ and a_x is positive, $x(t) = x_0 + \frac{1}{2}a_x t^2$ (starts from rest, purely accelerating). If time is very small, $x(t) \approx x_0 + v_{0x}t$ (the displacement in a very short time is dominated by initial velocity, as expected from calculus initial slope idea).

- **Use vs. siblings:** Use these formulas instead of doing calculus from scratch when acceleration is uniform – they are direct integrations of $\dot{x} = v, \dot{v} = a$. If acceleration is not constant (e.g. a depends on time or velocity), you cannot use them; you'd have to integrate or use more advanced formulas. For example, don't apply $v^2 = v_0^2 + 2a\Delta x$ if a is changing with position or time – that formula assumes constant a.

- **Common exam traps:** (1) Mixing up which formula to use – it helps to write down what you know (which variables) and what you need, then pick the equation that connects those. For instance, if time t is not asked or given, using $v^2 = v_0^2 + 2a\Delta x$ bypasses time. (2) Plugging vertical data into horizontal formulas or vice versa. Keep x and y equations separate: gravity g goes only in the vertical equation. (3) Sign errors: if you take upward as positive, then a downward acceleration is negative in these formulas. If v_{0y} is upward and g is downward, you might write $y(t) = y_0 + v_{0y}t - \frac{1}{2}gt^2$. Forgetting the negative on the gt^2 term will give a wildly incorrect result. Always double-check the sign convention with a simple test (e.g., is the y value decreasing as time increases after launch? It should after the apex).

Explanation: When dealing with motion in rectangular coordinates, the beauty is that you can solve each direction independently using the simpler one-dimensional kinematics formulas. In a projectile problem for example, you use one set of equations for horizontal motion (because it's uniform motion) and another set for vertical (uniformly accelerated motion). This divide-and-conquer strategy simplifies 2D motion into two 1D motions. On the FE exam, many problems explicitly or implicitly involve this: a package dropped from a moving plane (horizontal + vertical), a stone thrown upward, a car going over a cliff, etc. The Cartesian approach works because of the principle of superposition for perpendicular components – gravity doesn't affect horizontal motion and (in absence of drag) horizontal motion doesn't affect vertical fall. So you solve them separately and then recombine at the end (for example, to get the total velocity vector at impact, combine v_x and v_y via $\sqrt{v_x^2 + v_y^2}$ and $\tan^{-1}(v_y/v_x)$ for direction). The typical "projectile motion" results you might recall – like time of flight $t_{\text{flight}} = \frac{2v_0 \sin\theta}{g}$ (level ground) or range $R = \frac{v_0^2 \sin 2\theta}{g}$ – all come from these basic equations by elimination of parameters. You don't need to memorize those specialized formulas; it's safer to derive from fundamentals in case you blank out: write $y(t)$, set $y(t_{\text{land}}) = 0$ (if landing at initial height), solve for t_{land}, then plug in $x(t)$. That process also reduces errors because you're logically following the physics. One more thing: pay attention to units in mixed-unit problems (quite common in engineering scenarios). For example, a question might give speed in km/h and distances in meters – convert the speed to m/s before plugging into $x = vt$. Or if using $v^2 = v_0^2 + 2a\Delta x$, ensure v and v_0 are in the same units and a and Δx correspond (e.g. a in ft/s² and Δx in ft). On your FE reference handbook, you'll find the constant acceleration formulas listed (likely in the Dynamics section) – knowing how to quickly find them by keyword (*"constant acceleration"* or *"projectile"*) can save you time if you forget an equation or its exact form. But with practice, these become second nature.

Analysis: Let's illustrate a quick analysis of a projectile scenario: Suppose a ball is launched at $20\ \text{m/s}$ at 30° from horizontal ground. We want to know how far it goes (range). Break it down:

$v_{0x} = 20\cos 30^\circ \approx 17.32$ m/s, $v_{0y} = 20\sin 30^\circ = 10$ m/s. Using vertical motion, $y(t) = 0 + 10t - 4.905t^2$. Setting $y(t_{\text{land}}) = 0$ (back to ground) and solving: $10t - 4.905t^2 = 0$ gives $t(10 - 4.905t) = 0$, so $t_{\text{land}} = 0$ (launch moment) or $t_{\text{land}} \approx 2.039$ s. That's the flight duration. Now horizontal: $x(t) = 0 + 17.32 \times 2.039 = 35.3$ m. So range ≈ 35.3 m. While doing this, note how we kept track of each component separately. A common point of confusion is the velocity at impact: some might try to plug into vertical equations incorrectly. The proper way: at impact, v_x is still 17.32 m/s, $v_y = 10 - 9.81(2.039) \approx -10$ m/s (downward 10 m/s). Then total speed $|\mathbf{v}| = \sqrt{17.32^2 + 10^2} \approx 20$ m/s (interesting, it came back to launch speed in this symmetric case) and direction $\tan^{-1}(10/17.32) \approx 30^\circ$ below horizontal. This consistency (symmetric launch/landing gives same speed) can be a quick check. In exam problems, you might not need every piece, but stepping through logically like this ensures you have the right approach. One more thing: If the problem involves non-zero initial or final vertical displacements (like launched from a hill or landing at a different height), your equations adjust (y_0 not zero or final y not zero), but the approach remains splitting into independent 1D equations.

K07.T01.S03 – Motion in Planar Polar Coordinates (Radial and Transverse Components)

- **Polar Coordinate Description:** Instead of describing a particle's position by (x, y), we can describe it by (r, θ) in a plane, where $r(t)$ is the distance from a fixed origin to the particle, and $\theta(t)$ is the angle (typically from the positive x-axis) to the line connecting origin to the particle. This is useful for motion that has some natural "circular" aspect, such as something moving around a pivot or in an expanding spiral.
- **Unit Vectors ($\mathbf{e}r, \mathbf{e}\theta$):** At any instant, $\mathbf{e}r$ *is the unit vector pointing directly outward from the origin to the particle (radial direction), and* $\mathbf{e}\theta$ is the unit vector perpendicular to $\mathbf{e}r$*, pointing in the direction of increasing* θ *(transverse direction, tangential to the path). Importantly, unlike fixed Cartesian unit vectors,* $\mathbf{e}_r$ *and* $\mathbf{e}\theta$ rotate with the particle; they are *local* to the particle's current position.
- **Velocity in Polar Coordinates:** The particle's velocity can be decomposed into a radial component and a transverse (angular) component. If the particle's distance r is changing and/or the angle θ is changing, the velocity is $\mathbf{v} = \dot{r}\,\mathbf{e}r + r\dot{\theta}\,\mathbf{e}\theta$. Here $\dot{r}$ (the time derivative of r) is the radial velocity (positive if the particle is moving outward, negative if moving inward), and $r\dot{\theta}$ is the transverse velocity (essentially the tangential speed as it goes around the origin).
- **Acceleration in Polar Coordinates:** The acceleration has more terms because the directions $\mathbf{e}r$ *and* $\mathbf{e}\theta$ themselves change orientation as the particle moves. The radial acceleration component is $\ddot{r} - r\dot{\theta}^2$ and the transverse (angular) acceleration component is $r\ddot{\theta} + 2\dot{r}\,\dot{\theta}$. So $\mathbf{a} = (\ddot{r} - r\dot{\theta}^2)\mathbf{e}r + (r\ddot{\theta} + 2\dot{r}\,\dot{\theta})\mathbf{e}\theta$. The term $-r\dot{\theta}^2$ is often called the centripetal or radial **inward** acceleration (it's negative if $\dot{\theta} \neq 0$, indicating that part of acceleration points opposite to $+r$ direction, i.e., toward the center). The term $2\dot{r}\,\dot{\theta}$ is called the **Coriolis** acceleration term – it arises when the particle is moving radially and rotating at the same time.
- **When to Use Polar Coordinates:** If a problem involves a particle moving along a curved path that is naturally described by rotating coordinates (like something on a rotating arm, or a car moving in a circular path that is expanding), polar coordinates can simplify the math. Instead of dealing with $x(t)$ and $y(t)$ which might involve sines and cosines of a rotating angle, you deal with $r(t)$ and $\theta(t)$ directly. On the FE exam, typical uses could be: computing the acceleration of a point on a spinning wheel at a given radius and angular speed (here polar makes it straightforward: radial accel = $r\dot{\theta}^2$ inward, etc.), or analyzing something like a bead sliding outward on a rotating rod (where you'd include that Coriolis term).

Exam Handbook Search Cues (Not affiliated with or endorsed by NCEES): *polar coordinates, radial acceleration, transverse velocity, r dot, theta dot, centripetal, Coriolis*

Footnotes:

- *Sign conventions:* By convention, $\dot{\theta}$ is positive for counterclockwise rotation (increasing angle). Then $\mathbf{e}\theta$ *as defined (pointing CCW perpendicular to* $\mathbf{e}_r$*) makes the formulas consistent. A negative* $\dot{r}$ *means* r *is decreasing (motion toward the origin). If you plug in negative or positive values, the formulas automatically give the correct direction sense (because* $\mathbf{e}_r$ *and* $\mathbf{e}\theta$ take care of direction).

- *Coriolis term:* The $2\dot{r}\,\dot{\theta}$ term in acceleration might be unfamiliar if you haven't studied rotating frames deeply. It essentially accounts for the fact that if the radius is changing, the transverse direction $\mathbf{e}_\theta$ is itself rotating, causing an additional acceleration. In many common problems, either $\dot{r} = 0$ (e.g., constant radius motion) or $\dot{\theta} = 0$ (pure radial motion), in which cases that term drops out.

- *Units:* $\dot{\theta}$ is an angular velocity usually in rad/s (radians per second). Ensure you use radians in any calculation with $\dot{\theta}$ or $\ddot{\theta}$ unless specifically working in degrees and converting. For instance, if $\omega = 100$ rpm (revolutions per minute) and you need to use it in these formulas, convert ω to rad/s first: $100 \text{ rpm} \approx 10.47 \text{ rad/s}$.

Variations and Related Forms:

- **Constant r (circular motion):** If r is constant (the particle is just going around in a circle of fixed radius), then $\dot{r} = 0$ and $\ddot{r} = 0$. The formulas simplify: $\mathbf{v} = r\dot{\theta}\,\mathbf{e}\theta$ *(purely tangential velocity) and* $\mathbf{a} = -r\dot{\theta}^2\,\mathbf{e}_r + r\ddot{\theta}\,\mathbf{e}\theta$. If angular velocity $\dot{\theta}$ is also constant, then $\ddot{\theta} = 0$ and the acceleration further reduces to purely radial: $\mathbf{a} = -r\dot{\theta}^2\,\mathbf{e}_r$ (pointing toward the center, which is exactly the uniform circular motion centripetal acceleration). This special case is so important it gets its own treatment (see the next subtopic).

- **Constant θ (pure radial motion):** If the particle moves directly toward or away from the origin along a straight line, then $\dot{\theta} = 0$, $\ddot{\theta} = 0$. The formulas become $\mathbf{v} = \dot{r}\,\mathbf{e}_r$ and $\mathbf{a} = \ddot{r}\,\mathbf{e}_r$ – which is just one-dimensional straight-line motion along $\mathbf{e}_r$. That's consistent with intuition: if something goes radially outward without swinging around, it's just a line.

- **Central force problems:** In some dynamics contexts, a force toward a point (like gravity toward a planet or a tether to a pole) makes polar coordinates very handy because the acceleration naturally splits into radial (gravity/tether direction) and transverse (often related to angular momentum). While deriving central force motion is beyond FE scope, you might see conceptual questions or

simple computations (e.g. satellite orbital speed relates $r\dot{\theta}$ to gravity).

Equation Passport: Velocity and Acceleration (Polar Coordinates) – provides velocity and acceleration components in the plane using polar unit vectors.

- Equations:

Velocity: $\mathbf{v} = \dot{r}\,\mathbf{e}r\,; +;\ r\,\dot{\theta}\,\mathbf{e}\theta$
Acceleration: $\mathbf{a} = (\ddot{r} - r\,\dot{\theta}^2)\,\mathbf{e}r\,; +;\ (r\,\ddot{\theta} + 2\,\dot{r}\,\dot{\theta})\,\mathbf{e}\theta$

- Variables: $r(t)$ = radial distance to particle (m or ft); $\theta(t)$ = polar angle (rad); $\dot{r} = dr/dt$ = radial velocity (m/s); $\dot{\theta} = d\theta/dt$ = angular velocity (rad/s); $\ddot{r} = d^2r/dt^2$ = radial acceleration (m/s²); $\ddot{\theta} = d^2\theta/dt^2$ = angular acceleration (rad/s²); $\mathbf{e}r$ = unit vector pointing outward along radius; $\mathbf{e}\theta$ = unit vector perpendicular to $\mathbf{e}r$ in direction of increasing θ.

- Assumptions: The motion is confined to a plane (2D polar coordinates). The origin used for (r, θ) is a fixed reference (inertial frame). These formulas come from differentiating the rotating unit vectors and are always valid in an inertial frame; do not mix them up with non-inertial rotating observers (that's the next subtopic on relative motion).

- Limit checks: If $\dot{\theta} = 0$ (no angular change, motion purely radial), then $v = \dot{r}\,\mathbf{e}_r$ and $a = \ddot{r}\,\mathbf{e}_r$ – which is just 1D motion along $\mathbf{e}_r$ (sensible). If $\dot{r} = 0$ (radius constant) and $\ddot{\theta} = 0$ (rotation at constant rate), then $a = -r\dot{\theta}^2\,\mathbf{e}_r$ pointing inward, which matches our expectation of centripetal acceleration for uniform circular motion. If both $\dot{r}$ and $\dot{\theta}$ are zero (particle at rest), then obviously $\mathbf{v} = 0, \mathbf{a} = 0$. The Coriolis term $2\dot{r}\dot{\theta}$ is zero in both extreme cases (pure radial or pure circular), which checks out because it only appears when you have a combination of the two motions.

- Use vs. siblings: Use these polar forms when the geometry of motion or the forces involved suggest a natural polar relationship. For example, if a problem gives you an angular speed and a radial expansion rate and asks for acceleration, polar is the direct route. In contrast, if a problem is simpler in x, y (like standard projectile motion or straight-line motion), stick to Cartesian. Polar coordinates shine for rotation-centric problems – compare it with the normal-tangential coordinates (next subtopic) which are more general for any curved path. Normal-tangential (n, t) is tied to the path itself, while polar is tied to a fixed point (the origin). Use polar when that fixed point is physically relevant (like center of a circle or rotation).

- Common exam traps: (1) Confusing $\dot{\theta}$ (radians/s) with ω in RPM or degrees. Always convert angular measures to radians when using these formulas. (2) Dropping the $2\dot{r}\dot{\theta}$ term – it's easy to forget, but if both r and θ change, it's there. Students often remember centripetal $r\dot{\theta}^2$ and maybe tangential $r\ddot{\theta}$, but miss the Coriolis term. On a multiple-choice exam, an answer choice might correspond to leaving out $2\dot{r}\dot{\theta}$. (3) Sign errors: for instance, if r is decreasing ($\dot{r} < 0$) while $\dot{\theta} > 0$, the $2\dot{r}\dot{\theta}$ term is negative, meaning the transverse acceleration is in the $-\,\mathbf{e}\theta$ direction (opposite to motion direction, sort of like a "retarding" Coriolis effect). Keep track of signs via the formulas rather than intuition – trust the math.

Explanation: Planar polar coordinates provide a convenient framework for analyzing motions that involve rotation around a point. Imagine a point mass connected to a pole by a rope (like a tetherball) that's being let out: it's moving away from the pole (increasing r) while circling around (changing θ). Cartesian x, y equations for such motion would be messy, involving sines and cosines of the angle. But polar handles it neatly by directly using r and θ. On the FE exam, you likely won't be asked to derive the polar acceleration formulas (they are provided in the reference if needed), but you may be expected to apply them. For example, a typical question might give: "A point on a rotating arm has radial speed $\dot{r} = 2$ m/sand angular speed $\omega = \dot{\theta} = 3$ rad/sat an instant when $r = 0.5$ m. Determine the magnitude of acceleration." You'd plug into: radial accel $= -r\omega 2 = -0.5(32) = -\frac{4.5\ m}{s2}$ (inward), tangential accel $= 2\dot{r}\,\omega$ (since $\ddot{\theta}$ might be zero if not given, assume no angular acceleration) $= 2(2)(3) = 12\ m/s^2$ in the transverse direction. Then find the magnitude via $\sqrt{(4.5)^2 + (12)^2}$. The polar method directly gives these components without first computing some complicated $x(t), y(t)$. In applying these formulas, always carefully identify what values you're given: sometimes problems give linear speed and angular speed and you have to realize linear (tangential) speed $v_\theta = r\omega$, which is consistent with the velocity formula above. Another scenario: if a problem gives the equation of motion in polar form, e.g. $r(t)$ and $\theta(t)$ explicitly, you can differentiate to find velocity and acceleration. But keep in mind the unit vectors rotate, hence the extra terms – blindly differentiating a vector expressed in polar coordinates without accounting for moving unit vectors is a recipe for forgetting terms; that's exactly why we memorize or refer to these ready-made formulas.

Analysis: Let's do a brief check of dimensions and plausibility with polar formulas. Suppose a particle is on a rotating turntable at radius $r = 2$ m, with $\omega = 1$ rad/s (so $\dot{\theta} = 1$) and not moving radially ($\dot{r} = 0$). Then $\mathbf{v} = 0\,\mathbf{e}r + 2(1)\mathbf{e}\theta = 2$ m/s in the tangential direction (makes sense: $v = r\omega = 2$ m/s). Acceleration: $\ddot{r} = 0$, so radial part $= -r\dot{\theta}^2 = -2(1)^2 = -2\ \mathrm{m/s^2}$ (inward), transverse part $= 2\dot{r}\dot{\theta} + r\ddot{\theta} = 0 + 0 = 0$. So $\mathbf{a} = -2\ \mathrm{m/s^2}\ \mathbf{e}r$, *purely inward, magnitude* $2\ \mathrm{m/s^2}$. *That matches the known centripetal acceleration* $v^2/r = (2^2)/2 = 2\ \mathrm{m/s^2}$. *Good. Now if the radius were increasing at 0.5 m/s (outward) at that instant, then* $\dot{r} = +0.5$. *The instantaneous acceleration would get an extra transverse component* $2\dot{r}\dot{\theta} = 2(0.5)(1) = 1\ \mathrm{m/s^2}$ *in the* $\mathbf{e}\theta$ direction. That means as it spirals outward, there's a sideways acceleration component that arises (Coriolis) – physically, the object appears to get an extra "push" in the direction of motion as the radius increases (or a drag opposite if radius decreases). If you're curious, that's the same effect that, say, causes a person moving outward on a spinning carousel to feel a force. But for exam purposes, you just compute it. One more example: If $\dot{r}$ is negative (object moving inward) and ω positive, the $2\dot{r}\dot{\theta}$ term is negative, meaning the transverse acceleration is opposite to the direction of motion – effectively a deceleration in the tangential direction. This could happen if you pull a mass on a string inward; it tends to speed up angularly (conserving angular momentum), but from the perspective of requiring acceleration components, there's an interesting interplay. All said, polar coordinates are a powerful tool. If you keep the formulas handy (or know how to find them in the handbook under *Particle Kinematics*), you can tackle any planar motion problem that isn't purely straight or conveniently horizontal/vertical.

K07.T01.S04 – Special Cases of Particle Motion: Rectilinear Motion and Uniform Circular Motion

Case 1: Rectilinear (Straight-Line) Motion

- **Description:** Rectilinear motion means the particle moves along a straight line. This could be horizontal, vertical, or any fixed direction in space – the key is that the direction doesn't change. Essentially, it's one-dimensional motion.

- **Kinematics Simplification:** Because direction is fixed, we often drop the vector notation and treat displacement $s(t)$ as a scalar (with sign indicating direction relative to some origin). Velocity $v(t)$ and acceleration $a(t)$ are also scalars (with sign). All the general kinematic relationships then become simple algebraic ones. For example, $v = ds/dt$, $a = dv/dt$. We can also integrate: $s(t) = \int v\,dt$, $v(t) = \int a\,dt$.

- **Uniform Acceleration on a Line:** This is the most common scenario in exam problems – e.g., a car accelerating along a straight road, or an object in free fall (vertical line) under gravity (constant acceleration downward). In such cases, the **constant acceleration equations** listed earlier under subtopic S02 apply directly (with perhaps different symbols: often s is used for displacement along the line instead of x or y). We might write them as: $v = v_0 + at$, $s = s_0 + v_0 t + \frac{1}{2}at^2$, $v^2 = v_0^2 + 2a(s - s_0)$.

- **Graphical Interpretation:** On a velocity-time graph for rectilinear motion, the area under the curve is the displacement, and the slope of the curve is the acceleration. On an acceleration-time graph, the area under the curve is the change in velocity. Sometimes exam questions involve interpreting such graphs qualitatively or calculating areas (especially if acceleration is piecewise constant).

- **Example Contexts:** Free-fall and vertical throw (up/down under gravity) is rectilinear. Also, something like piston motion in an engine (back-and-forth along a line, possibly with varying acceleration) can be approximated piecewise or analyzed via calculus. Another example: two cars moving in a straight line – you might set up relative equations along that line to see when one overtakes the other (still 1D kinematics).

Case 2: Uniform Circular Motion

- **Description:** Uniform circular motion is motion along a circular path at a *constant speed*. The particle goes around a circle of fixed radius R with an unchanging speed v. While speed is constant, velocity is not (because direction is continually changing). This scenario is a subset of circular motion where the angular velocity ω is constant ($\dot{\theta} = \text{constant}$) and radial distance $r = R$ is constant.

- **Centripetal Acceleration:** The defining feature is a constant-magnitude acceleration directed toward the center of the circle (centripetal = "center-seeking"). Its magnitude is $a_c = \frac{v^2}{R} = \omega^2 R$. This acceleration points perpendicular to the velocity at every instant (toward the center). Because of this perpendicular acceleration, the particle's speed doesn't change – the acceleration is only changing direction of velocity, not magnitude.

- **Period and Frequency:** Two useful related quantities: the time to complete one full circle is the *period* $T = \frac{2\pi R}{v} = \frac{2\pi}{\omega}$. The *frequency* (number of revolutions per unit time) is $f = \frac{1}{T} = \frac{\omega}{2\pi}$. While not always directly asked, these concepts can appear, for example, "centrifuge rotates at 600 rpm – what is the centripetal acceleration at radius 0.2 m?" You'd convert 600 rpm to ω (radians/s), then apply $a_c = \omega^2 R$.
- **Dynamics Tie-in:** Though we're focusing on kinematics here, uniform circular motion is often where students recall Newton's second law in radial form: $F_c = m\,v^2/R$ is required to keep mass m moving in a circle. So if the exam question is about something like the tension in a string for a mass whirling in a circle, you'd compute the needed centripetal acceleration first from kinematics (v^2/R) then multiply by m.

Exam Handbook Search Cues (Not affiliated with or endorsed by NCEES): *rectilinear motion, constant acceleration, uniform circular, centripetal acceleration, v^2/r, circular motion*

Footnotes:

- *Rectilinear synonyms:* Problems or references might use terms like "linear motion," "one-dimensional motion," or specify motion along a line or axis (e.g. "along the x-axis"). All imply rectilinear scenarios.

- *Gravity as uniform acceleration:* All free-fall and projectile questions assume uniform gravity (no variation with height for the scales in question). So yes, vertical motion under gravity is an example of rectilinear motion with constant acceleration (just one that eventually reverses direction when going up then down).

- *Circular units:* If using $a_c = \omega^2 R$, remember ω must be in rad/s. If you use $a_c = v^2/R$, v can be any linear speed unit as long as R matches (both SI or both USCS). Converting rpm: rpm/60 gives rps (rev/s), multiply by 2π for rad/s.

Variations and Related Concepts:

- **Non-Uniform Circular Motion:** If the speed isn't constant, then you have tangential acceleration too. That becomes a more general case (addressed in the next subtopic, normal & tangential components). Uniform circular is just the special case where tangential acceleration $a_t = 0$ and only normal acceleration $a_n = v^2/R$ exists.

- **Horizontal Circles vs Vertical Circles:** Kinematically, uniform circular motion is the same regardless of orientation. But if thinking ahead, maintaining uniform speed in a vertical circle (like a mass on a string being spun in a vertical plane) actually requires varying tension to counter gravity; hence it's not a pure "uniform" motion unless additional forces applied. The exam may avoid such complexity, but conceptually, uniform circular motion is usually considered in a horizontal plane or neglecting external fields to truly be uniform.

- **Typical Values:** Centripetal acceleration can be surprisingly large even at moderate speeds if radius is small. For instance, a car turning with $v = 10$ m/s (about 36 km/h) on a curve of radius 10 m experiences $a_c = 100/10 = 10\ \text{m/s}^2$, which is about 1g. That's at a modest speed – so higher speeds or tighter turns generate multiples of g. The exam might expect you to compare a computed a_c to g (e.g., "the centripetal acceleration is 2.5g" meaning 2.5 times gravitational acceleration). Keep that in mind as a reality check: if you compute an acceleration for a rotating system that is dozens of times g at small radius, it could be correct (spinning devices can create huge accelerations).

Equation Passport: Centripetal Acceleration (Uniform Circular Motion) – gives the inward acceleration required for a particle to move in a circle at constant speed.

- **Equation:** $a_c = \frac{v^2}{R} = \omega^2 R$.

- **Name and purpose:** *Centripetal Acceleration – magnitude of acceleration toward center in circular motion.* It computes how

much acceleration (inward) is needed to keep an object moving along a circle of radius R at speed v (or angular speed ω).

- **Variables:** a_c = centripetal acceleration (m/s² or ft/s²); v = linear speed along the circle (m/s or ft/s); R = radius of the circular path (m or ft); ω = angular speed (rad/s). Note: v and ω are related by $v = \omega R$.

- **Assumptions:** Motion is circular (constant radius) and speed is constant. This formula specifically covers the *normal component* of acceleration in circular motion. There is no tangential acceleration in uniform circular motion. The direction of a_c is always toward the center of the circle (pointing along the radius inward).

- **Limit checks:** If $v = 0$ (particle not moving), $a_c = 0$ – no acceleration needed, trivially true. If $R \to \infty$ (circle becomes very large/flat), for fixed v, $a_c \to 0$ – a larger radius curve is "less sharp," requiring less centripetal acceleration, which aligns with driving intuition (gentle curves are easier to handle than tight ones). If $\omega = 0$ (no rotation), clearly $a_c = 0$. If ω is fixed and R grows, a_c grows (since $a_c = \omega^2 R$); at the same angular speed, points farther out have greater linear speed and thus more a_c – think of a turntable: the rim experiences more acceleration than points near the center at the same rpm.

- **Use vs. siblings:** Use this formula in any scenario of circular motion to compute the normal acceleration. If motion is not strictly uniform (speed changing), you can still use v^2/R to find the instantaneous normal component of acceleration at a given moment – just be aware there would also be a tangential component $a_t = \dot{v}$. But $a_n = v^2/R$ holds at any instant for *any* curvilinear motion along a path of radius R at that instant (even if speed is changing or path not a full circle – it's actually the same formula in normal-tangential coordinates). This is a good cross-check: subtopic S05's formula $a_n = v^2/\rho$ is essentially the same idea, with ρ (radius of curvature) playing the role of R.

- **Common exam traps:** (1) Confusing centripetal acceleration with centrifugal "force" – remember, a_c is inward acceleration of the object; there is no outward acceleration. In an inertial frame, the only acceleration is toward center. (2) Using the formula with inconsistent units, especially if mixing ω in rpm with R in meters. Always convert ω to rad/s or compute v in consistent units. (3) If asked for "centripetal force," don't forget to multiply by mass ($F = ma$) *and* indicate direction (it's toward the center). (4) Sign conventions: If you're using a coordinate pointing outward as positive (like radial coordinate r increasing outward), centripetal acceleration might come out negative (because it's inward). But usually, it's easiest to just report the magnitude v^2/R and state it's toward the center.

Explanation: Rectilinear motion and uniform circular motion are two extreme "simpler" cases of motion. Rectilinear has no directional change, only speed may change; uniform circular has constant speed but continuous directional change. On the FE exam, rectilinear motion problems are straightforward applications of 1D equations: they might involve objects speeding up or slowing down, perhaps reaching zero velocity (like a ball thrown up coming momentarily to rest at the top). Recognizing a problem as rectilinear is a cue to drop into one-dimensional solving mode – list your knowns (v_0, v, a, s_0, s, t) and use the appropriate constant-a equation or integration. Uniform circular motion problems often appear in contexts of rotation: e.g., finding how many g's a rotating device creates, or relating wheel RPM to centripetal acceleration for design. The main difference from rectilinear is conceptual: even with constant speed, there is acceleration present (which some find counterintuitive initially). So the exam might test that understanding, for instance by asking *"An object moves in a circle at constant speed. Which of the following is true about its acceleration?"* – the correct answer: "Acceleration is non-zero and directed toward the circle's center" (with magnitude v^2/R). This highlights that acceleration is about change in velocity vector, not just change in speed. Another typical question: given a rotating system's parameters, compute centripetal force, etc. These are usually plug-and-chug with v^2/R once you identify v or ω. If you find yourself with a circular motion problem where speed is *not* constant (say a car accelerating around a track), then you have both centripetal and tangential accelerations; that's when you shift to the general a_n and a_t approach (subtopic S05). But if it explicitly says constant speed or "uniform" circular motion, life is simpler.

Analysis: Let's run through a short rectilinear example: A car accelerates uniformly from rest, reaching 20 m/s in 5 s. How far does it travel in that time? We identify $v_0 = 0$, $v = 20$, $t = 5$, a (unknown constant). Use $v = v_0 + at$ to find $a = (20 - 0)/5 = 4\ \mathrm{m/s^2}$. Then use $s = s_0 + v_0 t + \frac{1}{2}at^2 = 0 + 0 + 0.5(4)(25) = 50$ m. Easy marks on the exam if you set it up right. Now a uniform circular example: Suppose a test tube in a centrifuge is 10 cm from the center, spinning at 1200 rpm. What's the centripetal acceleration? Convert 1200 rpm: that's $1200/60 = 20$ revolutions per second, $\omega = 20 \times 2\pi \approx 125.66$ rad/s. Then $a_c = \omega^2 R = (125.66)^2\,(0.10\ \mathrm{m}) \approx 1578\ \mathrm{m/s^2}$. Dividing by 9.81 gives about 161 g. So it's enormous – and indeed centrifuges create accelerations hundreds or thousands of times gravity. You might double-check by computing via v: $v = \omega R \approx 125.66 * 0.1 = 12.57$ m/s, then $v^2/R = (12.57^2)/0.1 \approx 1578\ \mathrm{m/s^2}$, consistent. The analysis pattern: identify that it's uniform circular (constant rpm given, radius given), then directly apply a_c formula. Another check: if the problem had been non-uniform, say an angular acceleration given, then it's not uniform circular motion; you'd handle by combining a_c and a_t if needed. But likely, FE problems keep them separate or clearly distinguish the two components. Finally, conceptually, never forget that rectilinear and uniform circular are simpler subsets of the next general case – understanding them will also help you tackle any complex motion by breaking it down (e.g., any curved motion at any instant has a momentarily circular path radius ρ and instantaneous speed v, so $a_n = v^2/\rho$ just like v^2/R). In summary, master the straight and circular extremes and you'll be well-prepared for intermediate cases.

K07.T01.S05 – Normal and Tangential Acceleration Components for Curvilinear Motion (Radius of Curvature Concepts)

- **Path Coordinates (t and n):** For any general curvilinear motion (the particle moves along some curved path), it's often convenient to describe acceleration in terms of components **tangential (t)** and **normal (n)** to the path. The *tangential direction* is along the path (direction of motion, unit vector $\mathbf{e}_t$), and the *normal direction* is perpendicular to the path, pointing toward the center of curvature of the path (unit vector $\mathbf{e}_n$, often pointing "inside" the curve).
- **Tangential Acceleration a_t:** This component is along the direction of motion and equals the time rate of change of the particle's speed. Simply put, $a_t = \frac{dv}{dt}$, where $v = |\mathbf{v}|$ is the speed. a_t is responsible for increasing or decreasing the speed (if a_t is positive in the direction of motion, the particle speeds up; if opposite, it slows down). If the problem says "speed is constant," then $a_t = 0$.

- **Normal (Centripetal) Acceleration a_n:** This component is perpendicular to the velocity (pointing toward the instantaneous center of curvature of the path). It accounts for the change in direction of the velocity vector. Its magnitude is $a_n = \frac{v^2}{\rho}$, where ρ is the **radius of curvature** of the path at that instant (the radius of the "osculating circle" that best matches the curve near that point). This can also be written as $a_n = v\,\dot{\theta}$ if $\dot{\theta}$ is the angular rate of turning, but it's safer to remember v^2/ρ. The normal acceleration is always directed toward the center of the curvature (hence inward, "centripetal"). It's sometimes denoted as a_c or a_n interchangeably, but we'll use a_n here to distinguish from the special uniform circular case.
- **Radius of Curvature ρ:** This is a property of the path's geometry at a point – basically how tight the curve is. A smaller ρ means a sharper turn (more curvature). If you have an explicit function for the path $y(x)$, ρ can be computed by $\rho = \frac{[1+(dy/dx)^2]^{3/2}}{|d^2y/dx^2|}$ for a planar curve. But in many FE problems, you'll either be given ρ or you'll recognize the curve (e.g., a circle of radius R has $\rho = R$ everywhere, a straight line has $\rho = \infty$).
- **Total Acceleration:** The vector acceleration $\mathbf{a}$ at any point can be written as $\mathbf{a} = a_t\,\mathbf{e}_t + a_n\,\mathbf{e}_n$. These components are perpendicular, so the magnitude of acceleration is $|\mathbf{a}| = \sqrt{a_t^2 + a_n^2}$. This decomposition is very useful in problems: for instance, if you need the friction needed to keep a car on a road that's curving and the car is accelerating, you'd consider the friction supplying both tangential (for speeding up/braking) and normal (for turning) components. On the exam, they might ask for one or the other component, or the total.

General curvilinear motion with tangential and normal components. The red curve represents an arbitrary path. At the specific red dot (particle's position), we draw the unit tangent $\mathbf{e}_t$ (green arrow, along the direction of motion) and unit normal $\mathbf{e}_n$ (green arrow, perpendicular to the curve, pointing toward the center of curvature C). The osculating circle (cyan) is shown passing through the point, with center C located at a distance equal to the radius of curvature ρ from the particle along the normal line. The velocity $\mathbf{v}$ (black arrow) is tangential to the path. The acceleration $\mathbf{a}$ (black arrow) is decomposed into a tangential component a_t (along $\mathbf{e}_t$, here shown as the small green arrow in the tangent direction) and a normal component a_n (along $\mathbf{e}_n$ toward the center of curvature). The tangential acceleration changes the particle's speed (making $\mathbf{v}$ longer or shorter), while the normal acceleration bends the trajectory (changing $\mathbf{v}$'s direction, pointing toward C). The figure's dashed red line indicates the normal line to the curve at the point, and the blue dot C marks the center of the curvature circle. This geometric interpretation shows that $a_n = v^2/\rho$: a higher speed or a tighter radius (sharp turn) increases the inward acceleration needed.

Exam Handbook Search Cues (Not affiliated with or endorsed by NCEES): *normal and tangential acceleration, curvature radius, v^2/r, a_n, a_t, radius of curvature*

Footnotes:

- *Terminology:* Tangential acceleration might also be called "linear acceleration along the path" and normal acceleration might be called "centripetal" or "radial" acceleration in some contexts. "Normal" here means perpendicular to the path, not "not weird" – don't let the word confuse you. Some texts use $\mathbf{a}_n$ for the normal component and $\mathbf{a}_t$ (or $\mathbf{a}_s$) for tangential. The FE Handbook might list them as such, or as a_n and a_t.

- *Direction of a_n:* It always points toward the center of curvature – effectively, toward the concave side of the path. If you imagine driving a car along a curvy road, a_n points inward on a turn (you feel pushed outward due to inertia, but the car's acceleration is inward). If the path is convex relative to your direction, the center of curvature might be "behind" you, but the formula v^2/ρ with a defined normal direction still works out. Usually, $\mathbf{e}_n$ is chosen to point toward the center of curvature.

- *Magnitude vs Sign:* $a_t = dv/dt$ can be positive or negative – positive if speed is increasing, negative if decreasing (i.e., braking). $a_n = v^2/\rho$ is always non-negative by that formula; the direction of a_n is taken care of by $\mathbf{e}_n$. You typically don't put a sign on v^2/ρ; instead, you know $\mathbf{e}_n$ is inward (so if you had to express it in a coordinate system, it might come out negative in an outward-pointing radial coordinate). Just be mindful that a_n by definition points inward.

Variations and Special Cases:

- **Straight-line motion:** For a straight path, $\rho = \infty$ (no curvature), so $a_n = v^2/\infty = 0$. Then as expected, $\mathbf{a}$ is entirely tangential (no centripetal component because you're not turning). This is a nice check: if you plug $\rho \to \infty$ into the formulas, they revert to straight-line kinematics.

- **Circular motion:** For a circle of radius R, $\rho = R$ everywhere. Then $a_n = v^2/R$ is constant in magnitude if v is constant, pointing to the center. a_t might be zero (uniform circular) or non-zero (speeding up around the circle). This is consistent with what we've discussed: the normal-tangential formulation is basically a generalized version of polar for the case of a general path.

- **Applications:** Many mechanical engineering scenarios use a_n and a_t. For example, the design of highway curves: $a_n = v^2/R$ must be small enough to provide sufficient friction (hence why highway curves have large R for given design speeds). Or roller coasters: at the top of a hill or bottom of a dip, the normal acceleration relates to what riders feel as "effective weightlessness or heaviness." A dip with radius of curvature ρ at speed v gives $a_n = v^2/\rho$ upward (toward center of curvature if track is concave up), making riders feel heavier by ma_n. The exam might indirectly test understanding by such contexts.

Equation Passport: Normal and Tangential Acceleration – resolves acceleration into components along and perpendicular to the path of motion (useful for any curvilinear trajectory).

- **Equations:**
Tangential component: $a_t = \frac{dv}{dt}$ (rate of change of speed).
Normal component: $a_n = \frac{v^2}{\rho}$.
- **Variables:** a_t = tangential acceleration (m/s² or ft/s²); a_n = normal (centripetal) acceleration (m/s² or ft/s²); $v = |\mathbf{v}|$ = speed (m/s or ft/s); ρ = radius of curvature of the path at that point (m or ft); t = time (s). $\mathbf{e}_t$ = unit tangent direction (direction of motion); $\mathbf{e}_n$ = unit normal direction (pointing toward center of curvature).

- **Assumptions:** The particle's trajectory is smooth and differentiable, so a unique tangent and normal can be defined at each point. ρ is typically positive (we choose the normal direction accordingly). This formulation doesn't require constant speed or anything – it's an identity decomposition of any acceleration vector

given the path geometry. It assumes an inertial frame and that we're analyzing acceleration relative to the path (not including any pseudo-forces as in rotating frames – that's separate).

- **Limit checks:** We already noted key limits: straight line ($\rho \to \infty$) gives $a_n \to 0$; constant speed ($dv/dt = 0$) gives $a_t = 0$. If the particle stops moving ($v = 0$), $a_n = 0$ because at an instant of zero speed, curvature doesn't contribute to acceleration (though if it's about to start turning, one could discuss limiting processes, but generally you need motion for a curvature-based acceleration). The expression v^2/ρ intuitively shows that at higher speeds, curvature bites harder (quadratically), and at larger radii, curvature effect is weaker (inversely). These match physical intuition and earlier formulas for circles.

- **Use vs. siblings:** Use a_n and a_t when the problem is about understanding what portion of acceleration changes speed vs direction. It's very helpful in mechanics problems, for instance: "A car accelerates while turning – what friction is required?" You'd find a_t from the speeding up and a_n from the turning, then combine for total. In pure kinematics questions, they might give you a trajectory and ask for curvature or a specific component of acceleration; that's a direct cue to apply these formulas. Compared to polar coordinates: a_n here is analogous to the radial acceleration $r\dot{\theta}^2$ (inward) and a_t analogous to the tangential $r\ddot{\theta}$ when motion is about a fixed center. But n, t coordinates can be used for any path, not just about a single origin – they ride along with the particle's path.

- **Common exam traps:** (1) Confusing $a_n = v^2/\rho$ with $a_n = \frac{d^2s}{dt^2}$ or something incorrectly. a_n is *not* d^2s/dt^2 – that latter would be related to a_t. Just remember a_n doesn't involve a time derivative explicitly, it's related to turning radius and speed. (2) Mixing up which is which: sometimes students mistakenly think the v^2/ρ component is along the path – it is not, it's perpendicular. A quick way to remember: the v^2/ρ formula has no sign (always positive scalar), so it must correspond to a direction that's predetermined (inward along normal). The one with dv/dt can be positive or negative, so that aligns with speeding up or slowing down along the tangent. (3) Calculating ρ incorrectly or not at all when needed. If the problem gives a path equation, you might need to compute ρ. The formula is on the handbook, but if you're short on time or it's messy, consider if there's a simpler way: e.g., if the question only needs a_n and you have v and the path equation, maybe directly use $a_n = \frac{(v^3)}{|d^2y/dx^2|}/[1 + (dy/dx)^2]^{3/2}$ by combining with $\frac{ds}{dt} = v$. That's too detailed perhaps – more straightforward: if numeric values are needed, plug into ρ formula. Or see if the curvature is of a known shape (like at the bottom of a vertical circle, ρ might just be the radius of that circle section). (4) Not recognizing when to use these: For example, if a problem gives an acceleration vector and asks for the normal component, you should be able to dot that acceleration with the normal direction or find $a_n = |\mathbf{a}| \cos\varphi$ if φ is angle between acceleration and velocity, but an easier way is often to compute v^2/ρ. If v and curvature info is accessible, use it.

Explanation: Expressing acceleration in normal and tangential components gives insight into what the motion is doing. a_t tells us how speed changes; a_n tells us how sharply we are turning. Many FE exam problems may not explicitly say "find a_n and a_t," but they might implicitly require it. For instance, a problem might describe a car that is braking (so it has a tangential deceleration) while going around a curve of known radius (so it has a normal acceleration), and then ask, "what is the total acceleration magnitude?" Here, breaking into a_t and a_n is the clean way to solve: compute each, then combine as perpendicular vectors. Or consider a roller coaster problem: at the bottom of a dip of radius ρ, the normal force on the passengers is related to $a_n = v^2/\rho$ plus g (because they feel 1g plus the centripetal force requirement). These scenarios are common in conceptual questions. If you're more on the pure math side, sometimes you get a parametric path, say $x(t), y(t)$, and you are asked for acceleration in some form. You could of course find $\ddot{x}, \ddot{y}$ and then project onto the tangent/normal, but the formulas $a_t = \dot{v}$ and $a_n = v^2/\rho$ give you a shortcut to interpret those second derivatives without heavy vector projection. It's worth noting that ρ can be computed if needed, but often exam problems sidestep heavy calculus by either giving ρ or using a simple path. For example, if a path is a circle or part of one, they'll likely just give the radius or let you infer it. If it's a parabola, computing ρ at a point is doable but maybe the problem will provide the curvature radius at that point. Being familiar with the concept of radius of curvature helps: at the top of a hill or bottom of a valley in a road, ρ is the radius of the "imaginary circle" that fits that curvature. A large ρ (gentle hill) means small normal acceleration, a small ρ (sharp dip) means large normal acceleration. This ties to how suddenly your direction changes. The combination formula $|\mathbf{a}| = \sqrt{a_t^2 + a_n^2}$ is just Pythagorean theorem, since $\mathbf{e}_t \perp \mathbf{e}_n$. For direction of **a** relative to **v**, you could find an angle if needed: $\tan(\alpha) = a_n / a_t$ where α is the angle of **a** measured from the tangent direction (if a_t and a_n were both nonzero). But rarely would that angle be asked explicitly on the FE – more likely they'd just want magnitudes or a component.

Analysis: Let's do a concrete calculation to illustrate using n, t components. Suppose a vehicle is moving at 20 m/s (~72 km/h) and decelerating at 3 $\mathrm{m/s^2}$ (tangential decel, i.e. braking) while entering a curve of radius $R = 100$ m. What's its total acceleration magnitude and direction? First, tangential component $a_t = -3\ \mathrm{m/s^2}$ (negative meaning opposite the direction of motion, i.e. slowing down). The magnitude for combination purposes is 3. Next, normal component $a_n = v^2/R = (20^2)/100 = 400/100 = 4\ \mathrm{m/s^2}$ directed toward center of curve. So the car's acceleration has a magnitude $|\mathbf{a}| = \sqrt{(-3)^2 + (4)^2} = 5\ \mathrm{m/s^2}$. The direction of **a** relative to the car's motion can be found: $\tan\alpha = a_n/|a_t| = 4/3$. So $\alpha \approx 53^\circ$ from the forward (tangent) direction, pointing inward and backward (since a_t was backward, a_n inward). In plain language, the car's acceleration is 5 m/s², directed somewhat more toward the center of the turn than straight backward. A driver or passenger feels this as a combination of getting pressed sideways and lurching forward against the seatbelt. The problem might simply ask "what is the magnitude of the total acceleration?" – you'd give 5 $\mathrm{m/s^2}$. Or it could ask "what friction acceleration is required to achieve this?" expecting you to combine them since friction must supply both. In either case, breaking it into normal and tangential makes it easy. Another scenario: find curvature given position and velocity and acceleration at an instant. You can use $a_n = v^2/\rho \Rightarrow \rho = v^2/a_n$. If you know the acceleration vector, you can get a_n by subtracting out any component parallel to velocity (that would be a_t). For example, if at some instant $\mathbf{v} = \langle 5,5 \rangle$ m/s (45° direction, speed $5\sqrt{2} \approx 7.07$ m/s) and $\mathbf{a} = \langle -5,15 \rangle$ m/s², you could find $a_t = \frac{d|\mathbf{v}|}{dt}$. Here $|\mathbf{v}| = 7.07$; if it changes by projecting **a** onto **v** direction: $a_t = (\mathbf{a} \cdot \hat{\mathbf{v}})$ where $\hat{\mathbf{v}}$ is unit vector along velocity. If you did that, you'd find some a_t, and then a_n as the perpendicular part. That's heavier than needed usually. Instead, you might note $a_n = |\mathbf{a}|$ if **a** is purely normal (when $a_t = 0$ i.e. speed constant), or use $\rho = v^3/|v \times a|$ formula sometimes taught (maybe beyond scope). But generally, the most straightforward approach is often conceptual rather than brute forcing with components: ask yourself, "is speed changing or just direction, or both?" Then apply the

appropriate formula pieces. All told, understanding a_t and a_n gives you a Swiss-army knife for tackling any motion by splitting it into easier parts. It's highly likely one or more FE questions will implicitly involve this, so it's worth practicing identifying those parts in various scenarios.

K07.T01.S06 – Relative Motion of Particles Using Translating or Rotating Reference Axes (Relative Velocity and Acceleration in Moving Frames)

Basic Relative Motion (Translating Frames): If you have two particles (or observers) A and B moving relative to each other, you can relate their velocities and accelerations by vector addition. The fundamental relation is: $\mathbf{v}A = \mathbf{v} + \mathbf{vA}$ relative to $\mathbf{B}$. *Similarly,* $\mathbf{a} = \mathbf{aB} + \mathbf{a}$, provided we're dealing with non-rotating (purely translating) reference frames. This is basically saying the velocity of A as seen from the ground (absolute) is the velocity of the reference B (perhaps a vehicle or platform) plus the velocity of A relative to B. It's like if you walk inside a moving train: your ground speed = train's ground speed + your speed relative to the train.

Examples of Translating Frames: A common FE example: Two cars moving – what is the velocity of one relative to the other? You subtract their velocities (taking care of direction). Another: a boat in a river where the water flows (take the water as frame B, boat relative to water plus water relative to ground gives ground velocity). Acceleration works similarly if the frame is just translating (no rotation): $\mathbf{a}A, \text{ground} = \mathbf{a}$. For instance, if a car accelerates and you jump inside the car, your acceleration relative to ground is car's acceleration + any jump acceleration relative to car. $+\,\mathbf{a}_{A,\text{relative}}$

Rotating Reference Frames (Coriolis Effects): When the reference frame is rotating (like observing from a spinning platform), relative motion analysis introduces additional terms. The full formula for a point A observed from a rotating frame attached to B (rotating with angular velocity $\boldsymbol{\omega}$) is more complex:

$$\mathbf{v}A = \mathbf{v} + \mathbf{vA/B}, \text{rel} + \boldsymbol{\omega} \times \mathbf{r},$$
$$\mathbf{a}A = \mathbf{a} + \mathbf{aA/B}, \text{rel} + \boldsymbol{\omega} \times (\boldsymbol{\omega} \times \mathbf{r}) + 2\,\boldsymbol{\omega} \times \mathbf{vA/B}, \text{rel} + \dot{\boldsymbol{\omega}} \times \mathbf{r}.$$

These look intimidating, but let's break down the meaning:

- $\mathbf{v}_{A/B,\text{rel}}$ is A's velocity relative to frame B (as if measured in B's rotating coordinate).
- $\boldsymbol{\omega} \times \mathbf{r}_{A/B}$ is the velocity of A due to frame B's rotation (if A is fixed in B, this would be exactly its velocity). Essentially, any position vector in a rotating frame sweeps out a velocity.
- On acceleration: $\boldsymbol{\omega} \times (\boldsymbol{\omega} \times \mathbf{r})$ is the centripetal acceleration term (if A is fixed in rotating frame, this is the inward accel needed).
- $2\,\boldsymbol{\omega} \times \mathbf{v}_{A/B,\text{rel}}$ is the **Coriolis acceleration** term. It appears when A is moving relative to the rotating frame. Its direction is perpendicular to both $\boldsymbol{\omega}$ and the relative velocity.
- $\dot{\boldsymbol{\omega}} \times \mathbf{r}$ is the **transverse (Euler) acceleration** due to angular acceleration of the frame (if the rotation rate is changing).

Practical approach to Rotating Frame problems: It's rare for the FE exam to expect derivation or heavy use of these general formulas, but understanding special situations is important. Common scenario: a point moving on a rotating wheel or turntable. If the point is fixed on the rotating body, relative velocity is zero, and the formulas simplify. For example, if A is a point on a spinning disk (frame B is center-of-disk), then $\mathbf{v}A = \boldsymbol{\omega} \times \mathbf{r}_A$ (centripetal + tangential components in rotating frame context). That's just another way to state polar results. (tangential velocity) and $\mathbf{a}_A = \boldsymbol{\omega} \times (\boldsymbol{\omega} \times \mathbf{r}_A) + \dot{\boldsymbol{\omega}} \times \mathbf{r}$

Another scenario: A projectile fired from a moving platform – relative velocity addition is straightforward if platform is not rotating. Or a plane drops a package – from plane's frame it just falls vertically, but from ground frame it has horizontal velocity equal to plane's. That's a relative velocity case (with translating frame).

Exam Handbook Search Cues (Not affiliated with or endorsed by NCEES): *relative velocity, translating axes, rotating frame, Coriolis, $\omega \times r$, moving reference*

Footnotes:

- *Notation:* Sometimes subscripts are used differently, e.g., $\mathbf{v}A/B$ *meaning velocity of A relative to B. It's crucial to understand which velocity is which. A handy memory device: "Absolute velocity of A = velocity of base (B) + velocity of A relative to B." Use the same point letter order on the relative velocity: A relative to B means A as seen from B.*

- *Sign conventions: If using a simple relative velocity in 1D, be careful with direction. For instance, if car A is going 60 mph east, car B 50 mph east, velocity of A relative to B = +10 mph (meaning A appears to B to go east at 10 mph). But relative of B seen from A = -10 mph (B appears to go 10 mph west from A's perspective). It's just opposite signs depending which way you subtract. Keeping track of "who relative to whom" with a consistent formula avoids confusion.*

- *Coriolis awareness: The Coriolis term* $2\omega \times v$ in acceleration is often misunderstood. In plain terms, if something is moving within a rotating frame, it experiences an apparent deflection. A classic example: a coin sliding outwards on a spinning turntable – to an observer on the turntable, the coin seems to curve (Coriolis), to a ground observer, the coin actually goes straight but you (rotating) move under it. For the FE exam, you likely won't need to calculate Coriolis acceleration for arbitrary values, but you should know qualitatively it exists and its direction (always perpendicular to the motion in the rotating frame). If a question involves, say, water draining (Coriolis effect on Earth's rotation) or projectiles in a rotating device, it may just be conceptual.

- *Non-inertial frames:* Remember, if you take a rotating or accelerating frame as your reference, you have to introduce inertial (fictitious) forces to apply Newton's laws in that frame. That's beyond kinematics – but just recall that normal relative velocity addition is fine, but for acceleration in a non-inertial frame, extra terms appear (which we listed).

Variations and Common Cases:

- **Two Translating Vehicles:** Probably the most straightforward – something like "Car A moves east at 30 m/s, Car B moves north at 20 m/s, what is velocity of B relative to A?" You'd subtract vectors: $\mathbf{v}_{B/A} = \mathbf{v}_B - \mathbf{v}_A$. Magnitude and direction can be found. That's just classic relative velocity in plane.

- **Aircraft in Wind:** The ground velocity of a plane is the vector sum of airspeed (plane relative to air) and wind velocity (air relative to ground). This is translating frame addition. These can be exam questions: e.g., plane aims north at 100 m/s (relative air), wind blows east at 20 m/s, find ground track and speed.

- **Conveyor belts or Moving Walkways:** If you walk on a moving walkway, relative motion addition again.

- **Rotating arms or turntables:** Suppose a bug crawls radially outward on a rotating disk. The bug's absolute velocity = disk's rotation effect + bug's crawl relative. If the disk spins at rate ω and bug moves outward at speed u (m/s) relative to disk, then absolute velocity has a tangential part $\omega \times r$ (perpendicular) and radial part u (outward). The bug's absolute acceleration will have centripetal ($\omega^2 r$ inward), tangential from any spin-up ($\dot{\omega} r$ if speed changes), plus a Coriolis $2\omega u$ in tangential direction due to outward motion. They might not explicitly ask for each term, but could test understanding qualitatively (e.g., "Why does the bug feel a sideways drift?" Answer: Coriolis effect from moving in a rotating frame).

- **Earth's rotation (Coriolis):** This is more in environmental engineering context (affecting large-scale flows), but mechanical could tangentially mention that any long-range motion on Earth is in a rotating frame, thus deflects (Coriolis). Not likely detailed in FE, but if it comes up, you'd just acknowledge Coriolis causes, say, a projectile fired north in northern hemisphere to drift east.

Equation Passport: Relative Velocity (Translating Frames) – relates velocities of two particles (or frames) in straight-line relative motion.

- **Equation:** $\mathbf{v}A = \mathbf{v} + \mathbf{vA/B}$.

- ***Variables:*** $\mathbf{v}_A$ *= velocity of particle A in the fixed (inertial) frame;* $\mathbf{v}_B$ *= velocity of particle (or frame) B in the fixed frame;* $\mathbf{v}$ = velocity of A relative to B (i.e., as seen from B). All in consistent units (m/s or ft/s).

- **Assumptions:** Frame B is not rotating relative to the fixed frame; it may translate (with possibly time-varying velocity). Essentially, B's axes remain parallel to the inertial frame's axes (no angular motion difference). Under this assumption, velocities add linearly. If rotation is involved, this simple addition doesn't hold without extra terms. Also assumes all motion is measured in the same coordinate sense (directions accounted).

- **Limit checks:** If B is stationary in the inertial frame ($\mathbf{v}B = 0$*), then* $\mathbf{v}_A = \mathbf{v}$ (as expected: if B isn't moving, A's velocity relative to B is just its absolute velocity). If A and B move together (so that A is stationary relative to B, $\mathbf{vA/B} = 0$*), then* $\mathbf{v}_A = \mathbf{v}_B$ *(A and B have the same velocity in the inertial frame, consistent). The formula is basically a linear combination, so nothing weird at limits.*

- **Use vs. siblings:** Use this for straightforward relative velocity situations – which are most relative motion problems unless rotation is explicitly present. If frames rotate, you must use the more complex form with $\omega \times r$ terms (which is like a sibling formula but more advanced). If the problem gives you a rotating reference scenario, identify it clearly – a common hint is mention of "Coriolis" or asking for something like "acceleration observed in rotating frame." If not, stick to the simpler formula.

- **Common exam traps:** (1) Reversing the relative velocity direction: $\mathbf{v} = \mathbf{vA} - \mathbf{v_B}$. But if asked for $\mathbf{v}$, that would be $\mathbf{vB} - \mathbf{v_A}$ (the negative). Carefully parse "of X relative to Y = v_X - v_Y." (2) Confusing position addition with velocity addition. The analogous position relation is $\mathbf{r}_A = \mathbf{r}_B + \mathbf{r}$, which is straightforward (like tip-to-tail of displacement vectors). Velocity is the time derivative of that, so it works similarly if frames aren't rotating. (3) Units/directions: ensure when adding velocities that they are in the same unit system and expressed in the same vector basis. Convert mph to m/s if needed, etc. (4) In 2D, you might need to do component-wise addition (north + east etc.). If an angle is given for one velocity, you may need to resolve into components before adding with another.

Equation Passport: Relative Acceleration (Rotating Frame) – (advanced, include if needed) accounts for acceleration differences when reference frame rotates.

- **Equation:**

$$\mathbf{a}A = \mathbf{a}_B + \mathbf{a} + \boldsymbol{\omega} \times (\boldsymbol{\omega} \times \mathbf{rA/B}) + 2\,\boldsymbol{\omega} \times \mathbf{v} + \dot{\boldsymbol{\omega}} \times \mathbf{rA/B}$$

- **Variables:** $\boldsymbol{\omega}$ = angular velocity vector of rotating frame B relative to inertial frame (rad/s); $\dot{\boldsymbol{\omega}}$ = angular acceleration of frame B (rad/s²); $\mathbf{r}$ = position vector of A relative to origin of frame B; $\mathbf{vA/B}$, rel and $\mathbf{a}$ = velocity and acceleration of A relative to frame B's coordinates. $\mathbf{aA}$ = absolute acceleration of A; $\mathbf{a}_B$ = absolute acceleration of origin of frame B.

- **Assumptions:** Frame B can translate and rotate relative to inertial frame. A/B relative values are measured in frame B coordinates (so they include no effects of B's motion). This formula is general (essentially from transporting derivative in rotating frames). Using it correctly requires identifying each term. Usually, one deals with a simpler subset (like steady rotation $\dot{\omega} = 0$, or A fixed in B so $\mathbf{v} = 0$, etc.)

- **Limit checks:** If $\boldsymbol{\omega} = 0$ (frame B not rotating, purely translating), many terms drop out: the double cross and Coriolis terms are zero, and it simplifies to $\mathbf{a}A = \mathbf{a}_B + \mathbf{a}$ as expected. If additionally frame B is not accelerating ($\mathbf{aB} = 0$), then $\mathbf{a}_A = \mathbf{a}$ – also sensible. If A is fixed in B (so $\mathbf{vA/B}$, rel $= 0$, $\mathbf{a} = 0$) and B is rotating at constant ω, the formula yields $\mathbf{aA} = \mathbf{a_B} + \boldsymbol{\omega} \times (\boldsymbol{\omega} \times \mathbf{r})$. If B's origin is also fixed ($\mathbf{aB} = 0$), that is just $\boldsymbol{\omega} \times (\boldsymbol{\omega} \times \mathbf{r}_A)$, which is the centripetal acceleration of point A on a rotating body – checks out. If ω is changing ($\dot{\omega} \neq 0$) and A fixed in B, then an additional $\dot{\omega} \times$ r (transverse acceleration) appears, which matches expectations for a point on a body that's speeding up its rotation.

- **Use vs. siblings:** Use this full form only if you have a rotating-frame problem and need precise acceleration values. It's really just a combination of earlier concepts: the term $\boldsymbol{\omega} \times (\boldsymbol{\omega} \times \mathbf{r})$is the centripetal acceleration, $2\boldsymbol{\omega} \times \mathbf{v}_{\text{rel}}$is the Coriolis acceleration, and $\dot{\boldsymbol{\omega}} \times \mathbf{r}$is the tangential (Euler) term, plus any straightforward translating components of the origin. If an exam question explicitly mentions something like "Coriolis acceleration," this is the go-to reference. Most often, though, FE problems use simpler setups or just test conceptual understanding, so you don't always plug numbers into the full formula—usually you just recognize which terms are present and how they affect the motion.

- **Common exam traps:** (1) Not recognizing when to include Coriolis. If you have a particle moving in a rotating frame (like the bug on a spinning disk example), forgetting $2\omega \times v_{\text{rel}}$ will give a wrong answer. For instance, computing acceleration of bug relative to ground by just adding centripetal and the bug's own radial accel might miss the Coriolis effect if the bug has radial velocity. (2) Confusing reference frames: Always clarify which frame you're in

when applying these formulas. A sure sign you might need them is if the problem asks what an observer in a rotating frame measures (like "what acceleration does the person on the carousel see for the ball?"). (3) Overusing it – if the frame isn't rotating, don't throw in these extra terms accidentally. Keep track: rotation = need cross products; no rotation = simple addition.

Explanation: Relative motion is conceptually straightforward when frames are just shifting: it's like you running on a moving sidewalk – you add velocities. But once frames rotate, things get less intuitive. The FE exam primarily expects you to handle the straightforward cases of translating references and maybe some awareness of rotating cases. For translating frames, always draw a mental picture: If A moves relative to B, and B moves relative to ground, how do those motions combine? Vector arrows help: put B's velocity arrow tail at ground, then from B's head, draw A relative to B. The resulting arrow from ground to A is A's ground velocity. This visualization can solve most relative velocity questions. For acceleration, if frames are just accelerating linearly, it's the same process: add the frame's acceleration to relative acceleration. Many times a problem will give positions of A and B as functions of time – differentiating can yield velocities, then it's about subtraction to find one relative to the other. One common pitfall: if they say "relative speed" or "approach speed" between two objects, that's the magnitude of the relative velocity vector, which might require combining components. For example, two cars at a right angle: relative speed = vector difference magnitude. As for rotating frames, an engineer should know qualitatively that when observing from a rotating frame, there appear to be fictitious forces (like Coriolis) and accelerations. The exam might not have you compute a random Coriolis effect, but could include a conceptual question like: "A turntable rotates at constant rate. A bug crawls radially outward. Compared to an outside observer, which additional acceleration does the bug experience?" Answer would mention the $2\omega\, v_{\text{radial}}$ Coriolis acceleration perpendicular to its motion. Or possibly a question about throwing a ball on a merry-go-round – will it appear to curve. These are more conceptual. However, be prepared for at least a basic calculation: e.g., "Point on a rotating arm: find total acceleration." That's essentially what we did with polar coordinates earlier, but you can view it as a relative motion: point relative to arm (maybe fixed or moving radially) plus arm's rotation. The heavy formula above is in the Handbook if needed (likely under dynamics section), so you could use it if you don't remember. But often it's easier to derive the needed bits with polar or logic. A big takeaway: relative velocity addition is linear (no fancy terms), but relative acceleration addition is not linear if rotation is involved – new terms appear. This is because acceleration involves how the frame's rotation affects things. If you keep that straight, you'll avoid blending the two incorrectly.

Analysis: Let's consider a straightforward application: *Translating frame example:* A ferry is moving east at 5 m/s. A person walks on the deck at 2 m/s toward the front (east). What is the person's speed relative to the water? Simply add: $5 + 2 = 7$ m/s east. That's trivial. If the person walked opposite to ferry motion at 2 m/s, then relative to water: $5 + (-2) = 3$ m/s east (still east but slower than ferry). If asked relative to the ferry: that's given (2 or -2 m/s depending on direction). Now a bit more complexity: *Two cars at an intersection:* Car A going north at 30 m/s, Car B going east at 40 m/s. What is velocity of B relative to A? That's $\mathbf{v}B - \mathbf{v}_A = \langle 40,0\rangle - \langle 0,30\rangle = \langle 40,-30\rangle$ *m/s (taking north as +y, east as +x).*

Magnitude $= \sqrt{40^2 + (-30)^2} = 50$ *m/s, direction is arctan(30/40)=36.87° south of east (or relative to A's perspective, B appears to move southeast). This is simple vector subtraction but good to practice. For rotating frames: Imagine a point on a rotating wheel (radius 0.5 m) spinning at 10 rad/s (constant). If the point is fixed on the wheel, what acceleration does it have in ground frame? Using rotating frame formula simplified:* $\omega = 10$, $r = 0.5$, *no relative motion (*$v\,r = 2 = 0, a_{rel} = 0$), ω constant ($\dot{\omega} = 0$). So $\mathbf{a} = \boldsymbol{\omega} \times (\boldsymbol{\omega} \times \mathbf{r})$. The magnitude $a = \omega^2\, r = 100 * 0.5 = 50$ m/s² toward center. That matches earlier knowledge. If the wheel were speeding up, say $\dot{\omega} = 2$ rad/s², then there'd be an additional tangential $= \omega 0.5^{\cdot} = 1$ *m/s². So total acceleration vector would have a 50 m/s² inward and 1 m/s² tangential forward (if speeding up). Magnitude ~ 50.01 (nearly the same, direction slightly off radial). If a bug on the wheel crawls outward at 0.1 m/s, then relative radial velocity* $v_{rel} = 0.1$. *Now use polar or relative: absolute acceleration gets a Coriolis* $2\omega\, v_{rel} = 210 * 0.1 = 2$ m/s² in tangential direction (since bug moving outward, Coriolis tends to lag it behind rotation direction if wheel spinning). Additionally, since bug is moving outward, it has relative radial acceleration maybe 0 if constant speed. So now a_n centripetal at that instant is based on current radius (which is increasing, but consider moment): if radius currently 0.5, $\omega = 10$, centripetal = 50 m/s² inward. Tangential acceleration: wheel might still have 1 m/s² from spin-up, plus Coriolis 2 m/s² (direction depends on sign conventions but magnitude 2). So tangential net might be 3 m/s² (if both forward direction). So bug's total accel: 50 inward, 3 forward (tangential). $\sqrt{50^2 + 3^2} \approx 50.09$. The direction is only slightly off radial (a 3.4° lead). The main contributor is still centripetal. Without doing the fancy formula, we could've reasoned that too. But it's nice to see how pieces sum. For FE, if such a scenario came up, likely they'd break it into parts: like "compute centripetal and Coriolis accelerations separately" or conceptual: "in the rotating frame, the bug experiences a Coriolis force." In summary, focus on mastering the simpler relative velocity formula for translating frames and remembering qualitatively that rotating frames add centripetal and Coriolis terms for acceleration. That will cover most exam situations without getting lost in vector cross products.

Topic 02 - Kinetic Friction

Topic Introduction – What & Why: Kinetic friction is the resistive force that acts between two surfaces when they slide against each other. It's a fundamental concept in dynamics problems because it **opposes motion and dissipates energy**, affecting how objects accelerate or come to a stop. On the FE Mechanical Exam, you'll often encounter kinetic friction in questions like *a crate sliding across a floor* or *a block on an inclined plane with friction*. Knowing how to include the friction force in Newton's second law or energy equations is crucial – it can determine whether an object **slows down, moves at constant speed, or requires extra force to keep moving**. In short, kinetic friction matters on exam day whenever something is sliding, ensuring you account for that "hidden brake force" that fights against motion.

K07.T02.S01 – Kinetic Friction Force (Sliding Friction)

Principle at a Glance: Kinetic friction is the constant frictional force that acts **once surfaces are in relative motion** (sliding). Key intuitive points:

- **Resistive force during sliding:** When two surfaces are sliding against each other, kinetic friction is the force resisting their relative motion. It's what makes a sliding object slow down and eventually stop if no other forces keep it moving.
- **Opposes direction of motion:** The friction force always acts opposite to the direction of sliding. If a box slides to the right, friction points to the left (and vice versa). It **never pushes in the direction of motion** – it's always a retarding force.
- **Proportional to normal force:** The magnitude of kinetic friction F_k is proportional to how hard the surfaces press together (the normal force N). This relationship is **linear**: increase the normal force and friction increases in direct proportion. (Double the load on a sled, and friction doubles roughly.)
- **Coefficient of kinetic friction (μ_k):** The constant of proportionality μ_k (mu sub k) is a **dimensionless coefficient** that depends on the two materials in contact. Typical values range from ~0.05 (very slippery, e.g. ice) up to ~0.6 (very rough, e.g. rubber on concrete). Importantly, μ_k is usually **lower than the static friction coefficient** μ_s for the same surfaces – meaning it's easier to keep something sliding than to start it sliding.
- **Nearly constant with speed:** For the range of speeds encountered in most FE exam problems, kinetic friction can be treated as **constant**, independent of sliding velocity. (At very low speeds, friction stays roughly the same; high-speed effects or lubrication are beyond our scope.)
- **Include in dynamics equations:** In dynamics problems, treat F_k like any other force in your free-body diagram. It will appear in $\sum F = m\,a$ (usually with a negative sign if you call the motion direction positive) or as a work term $-F_k\,d$ in energy equations. Always account for kinetic friction when the problem states a "rough" surface or gives a μ_k value – it can change the acceleration or energy balance significantly.

Equation Passport – Kinetic Friction Formula: This is the core formula governing kinetic (sliding) friction on the FE Exam, encapsulating how to compute the frictional force when an object is sliding:

Name & purpose: Kinetic Friction Force – computes the frictional force resisting sliding motion between two contacting surfaces that are moving relative to each other. It answers: "How much force is friction exerting to oppose the motion?"

Equation: $F_k = \mu_k\ N$

(The friction force equals the coefficient of kinetic friction times the normal force.)

Variables and units:

- F_k = kinetic friction force (resistance force opposing motion), in newtons (N) in SI or pounds-force (lbf) in US customary units.
- μ_k = coefficient of kinetic friction (dimensionless ratio, no units).
- N = normal force between the surfaces (the perpendicular contact force), in N or lbf (must use the same force unit as F_k).

Assumptions and scope:

- Surfaces are in **steady sliding contact** (object is moving) – this formula applies after motion has started (for static/no motion, use static friction concepts instead).
- Dry contact with no significant lubrication or fluids between surfaces (classical dry friction).
- Frictional force is **independent of the contact area** between surfaces – it depends only on N and the material (this is an idealization of dry friction).
- Valid for typical engineering materials and **moderate sliding speeds** – at very high speeds or with temperature rise, μ_k can change, but those effects are beyond FE exam scope. We assume μ_k is constant for the problem at hand.

Limit tests (sanity checks):

- If $\mu_k \to 0$, then $F_k \to 0$ – this corresponds to a frictionless surface (e.g. a nearly frictionless ice or a well-lubricated interface), as expected no friction force opposes motion.
- If the normal force $N = 0$ (no contact pressure, like the object barely touching or in free fall), then $F_k = 0$ as well – no normal force means no friction.
- Because the relationship is linear, if you **double** μ_k, the friction force doubles (for the same N). If you double the normal force N (e.g. by stacking a second identical box on top of the first), F_k doubles accordingly.
- In reality, μ_k for most dry surface pairs is $\mathcal{O}(0.1\text{–}1.0)$, so the friction force is at most on the order of the object's weight. A hypothetical extremely large μ_k (>>1) is uncommon and would mean friction force exceeds the object's weight – not typical in exam scenarios.

Use vs. sibling equations: Use this **kinetic friction formula** ($F_k = \mu_k\ N$) instead of the static friction expression ($F \le \mu_s\ N$) **once the object is sliding**. In other words, once motion has begun,

drop the "≤" inequality and use the equality with μ_k. For **stationary or impending motion** cases, you'd consider static friction (and its maximum $F_{\max} = \mu_s N$), but **for any moving body on a surface, stick with** $F_k = \mu_k N$.

Common exam traps and mistakes:

- **Mixing up μ_s and μ_k:** Students sometimes plug in the wrong friction coefficient. Remember μ_s (static) is for no-sliding situations and gives a max possible value. Once sliding, always use μ_k. The problem will usually specify which coefficient to use; if it says "the object is sliding," go with μ_k.
- **Mass vs. weight confusion:** In SI units, you must convert mass to force to find N. If a block's mass is 10 kg, its weight $W = mg = 10 \times 9.81 \approx 98$ N. Using "10" in the formula without converting (thereby treating 10 kg as if it were 10 N) is a common mistake – it underestimates friction by a factor of ~9.81. In US units, be careful to distinguish lbm (mass) from lbf (force); usually, the exam gives weights directly in lbf, which you can use as N.
- **Wrong normal force:** On an incline or if additional vertical forces are present, N is not necessarily equal to the full weight mg. A classic mistake is to use $N = mg$ on a sloped surface – the correct normal is $N = mg\cos\theta$ on an incline (assuming no other vertical forces). Always solve for the normal force from the vertical force balance before plugging into $F_k = \mu_k N$.
- **Sign and direction errors:** Friction always opposes motion, but in setting up $F = m\,a$ equations, it's easy to drop a negative sign. For example, if you take the direction of motion as positive, friction enters with a negative sign (e.g. $+P - F_k = m\,a$ for a pulling force P overcoming friction, or just $-F_k = m\,a$ if friction is the only horizontal force slowing something down). If your result shows friction accelerating an object or doing positive work, you likely have the direction flipped in your equations.
- **Ignoring "frictionless" hints:** If a problem describes a surface as "smooth," "frictionless," or says "neglect friction," then $\mu_k = 0$ for that surface and you should not include a friction force. Missing that cue and erroneously adding friction can derail the solution. Conversely, if a problem gives a μ value or says "rough surface," make sure to include the friction force.

Exam Handbook Search Cues (Not affiliated with or endorsed by NCEES): *When using the exam's on-screen reference, search for keywords like "friction", "coefficient of friction", "kinetic friction", or the Greek letter "μ" to quickly find friction-related formulas. Also, look for "friction force" or "μ_k" in the dynamics section of the handbook. These terms will direct you to the reference info for friction.* (Knowing these keywords helps you locate the formula $F_k = \mu_k N$ fast during the exam.)

Footnotes and Nuances:

- **Unit consistency:** The coefficient μ_k has no units – it's a pure ratio. But F_k and N must be in the **same unit system**. In SI, use newtons (N) for forces (remember 1 kg of mass corresponds to 9.81 N of weight). In US Customary units, if weights/forces are given in pounds-force (lbf), use those consistently (don't multiply a weight in lbf by g – it's already a force).

- **Normal force basics:** For a horizontal surface with no extra vertical forces, N equals the object's weight $W = mg$. If the problem involves an incline or vertical pushes/pulls, compute N from the equilibrium in the perpendicular direction. (E.g. on an incline, $N = mg\cos\theta$ assuming the only forces normal to the surface are the object's weight component and the reaction.) Always double-check N before computing friction.

- **Static vs kinetic:** It bears repeating – kinetic friction applies **after motion starts**. If an object is initially at rest, static friction will act up until the threshold of motion. The instant the object breaks free and slides, kinetic friction takes over and usually has a slightly lower value ($\mu_k < \mu_s$ typically). The exam may implicitly test this by giving both μ_s and μ_k and expecting you to use the correct one at the correct stage of motion.

- **"Smooth" means $\mu = 0$:** Common phrasing in problems like "a block slides on a smooth surface" means assume $\mu \approx 0$ – essentially no friction. In contrast, "rough surface" implies friction is present (they will usually provide a μ value in that case). Keep an eye out for these descriptors so you don't accidentally include or omit friction.

- **Energy loss:** Because kinetic friction converts mechanical energy into heat, you'll sometimes see it in work-energy problems. The negative work done by friction over a distance d is $-F_k\,d$. This simply means friction gobbles up $F_k \times d$ amount of kinetic energy (or work input) as heat. It's another way to account for friction's effect if you're not using $F = ma$ directly.

Variations, Related Forms & Typical Values:

- **Inclined surfaces:** If an object slides on an incline of angle θ, the normal force is $N = mg\cos\theta$ (assuming m is the mass and g gravity). The kinetic friction formula still applies: $F_k = \mu_k N = \mu_k\, mg\cos\theta$, directed **up the incline** if the object is sliding down (opposing the motion), or down the incline if something is sliding up. The key is still that friction = μ_k times the normal component of weight.

- **Work-energy form:** In problems using energy methods, you might not explicitly calculate F_k via ma. Instead, you'll note that friction removes energy: $\Delta E = -F_k\,d$ (force times distance, with a minus sign). For example, if a sled slides to a stop over distance d, the loss of kinetic energy $\frac{1}{2}mv^2$ equals $F_k\,d$. You'd solve $F_k\,d = \frac{1}{2}\,m\,v^2$ to find d or use $F_k = \mu_k N$ to find the friction force first – both approaches are valid and stem from the same formula.

- **Typical μ_k values:** On the FE exam you'll be given μ_k when needed, but it helps to have a feel: **metal on metal** (~0.2 with no lubrication), **wood on wood** (~0.3), **rubber on concrete** (~0.5–0.7), **ice on ice** (~0.03). Most dry material pairs fall in the 0.1–0.6 range for kinetic friction. If you ever get an unrealistic μ_k (like > 1.0) in a problem, double-check inputs – extremely high friction coefficients usually indicate something like adhesion or an error.

- **Smooth vs rough approximation:** If a problem doesn't mention friction, you can usually assume surfaces are frictionless (especially if it says "smooth"). Only include a friction force if a coefficient or description of roughness is provided. Conversely, if μ_k is given, *use it*. Neglecting a provided friction coefficient is a surefire way to get the wrong answer.

- **Multiple surfaces or contacts:** Occasionally, a problem might involve friction at more than one interface (e.g., a block sliding

inside a channel, with friction on both top and bottom). In such cases, you'd calculate friction force for each contact surface ($F_{k1} = \mu_k N_1$, $F_{k2} = \mu_k N_2$, etc.) and include the sum of all friction forces in your force balance. The principle remains the same for each interface.

Special Notes – Calculator inputs: For the allowed FE exam calculators, using the kinetic friction formula is straightforward – it's simple multiplication. Just be careful with parentheses and scientific notation if μ_k is a small decimal. For example, if $\mu_k = 0.25$ and $N = 1500$ N, you might input 0.25 * 1500 to get 375 N. There's no special function or syntax needed beyond basic arithmetic. The most important "calculator skill" here is unit conversion: if you need to find N from a mass, compute mg (e.g., enter 50 * 9.81 for a 50 kg mass to get 490.5 N). Always double-check that you've input the correct value for N before multiplying by μ_k.

Explanation (Usage in FE Problems): The formula $F_k = \mu_k N$ is your go-to tool whenever you have a *sliding object* in a problem. In an exam scenario, once you identify that something is moving against a surface with friction, you'll calculate F_k to figure out how friction is influencing the motion. For example, if a 100-kg crate is sliding across a warehouse floor with $\mu_k = 0.30$, you quickly find $N = 100 \times 9.81 \approx 981$ N (its weight) and thus $F_k = 0.30 \times 981 \approx 294$ N. That 294 N is the force **opposing the motion** – you'd plug that into $\sum F = m\,a$ (with a negative sign if you set the direction of motion as positive) to find the crate's acceleration or to determine what force is needed to keep it moving. In essence, kinetic friction tells you **"how much force is fighting against the motion."** It's crucial for questions asking "Will the object slide? How fast will it slow down? How far will it go before stopping?" and so on. By mastering this formula, you'll handle those questions with confidence: identify the normal force, multiply by μ_k, and you have the frictional force ready to use in your equations.

Analysis (Step-by-Step Breakdown): Let's break down $F_k = \mu_k N$ term by term and see how it plays into solving problems:

The friction force F_k: This is the output of the formula – the force of friction in newtons (or lbf). Physically, F_k is what you'd feel if you tried to slide the object; it's the **tug-of-war force** that the surface exerts opposite the motion. In calculations, once you find F_k, you will include it in your force balance. For instance, if a box is being pulled to the right, your Newton's 2nd law equation might be $F_{\text{pull}} - F_k = m\,a$. If the box is just sliding freely (no pull, just friction slowing it), the equation would be $-F_k = m\,a$, leading to $a = -F_k/m$. (Which often simplifies to $a = -\mu_k\,g$ on a horizontal surface, a handy result to remember – the acceleration due to kinetic friction on flat ground is $-\mu_k\,g$.) The negative sign tells you the acceleration is opposite to the velocity – i.e. it's a deceleration. Always interpret F_k as acting opposite the motion in your FBD: if your object is moving right, F_k goes left, and vice versa. This ensures you plug it into equations with the correct sign.

The coefficient μ_k: This Greek letter "mu-sub-k" is a unitless number that characterizes the frictional interaction of the two surfaces. It's essentially a **friction index** – higher means stickier surfaces. You'll either be given μ_k in the problem, or given enough info to infer it (for example, they might give initial speed, stopping distance, and you solve for μ_k via energy or kinematics). Always check that you're using the kinetic coefficient and not mistakenly using μ_s. A typical exam trick is to provide both and see if you know when to use which. Since μ_k is dimensionless, you just use it as-is in calculations. One thing to keep in mind: because μ_k is often a decimal (like 0.2 or 0.5), multiplying by N might give you a non-integer or an odd number – that's fine. Also, μ_k doesn't require any conversion between unit systems; whether you're using newtons or pounds, μ_k stays the same value. If an object is on the borderline of moving, you might compare μ_s vs the required friction – but once it's sliding, μ_k governs the friction force without any "≤" inequality.

The normal force N: This is the supporting force perpendicular to the surface. It's equal in magnitude to the component of the object's weight pressing into the surface (plus or minus any other perpendicular forces). Computing N correctly is **half the battle** in friction problems. If the problem is straightforward (say a box on a horizontal floor with no extra vertical forces), then $N = W = mg$. But don't assume that blindly: always ask "what forces act perpendicular to the surface?" If it's on an incline, only part of the weight acts into the surface ($N = mg\cos\theta$). If someone is pushing down on the object, N increases (you'd add the downward push to mg). If someone is pulling the object *upward* at an angle or it's on an accelerating elevator, N decreases. So calculate N methodically from the problem's conditions. Once you have the correct N, plug it into $F_k = \mu_k N$. The friction force will be in the same unit as N. A common pitfall is mixing up mass and weight here: remember N has to be a force. For example, if a problem gives you a 50 kg object, that 50 kg is not the force – it's the mass. Multiply by 9.81 m/s^2 to get the weight in newtons (about 490 N) to use as N (assuming a horizontal surface and no other vertical forces). In US units, if they say the object weighs 100 lbf, then $N = 100$ lbf (again, on a horizontal surface). Paying attention to this step ensures you compute friction correctly.

Putting it all together (using F_k in problems): Once you determine F_k, you use it in whatever mechanics approach the problem calls for. In a force/acceleration problem, include F_k in the net force sum with the proper direction. For example, say a 10 kg sled is pulled with a 100 N force on rough ground ($\mu_k = 0.1$). You'd find $N = 10 \times 9.81 = 98.1$ N, then $F_k = 0.1 \times 98.1 \approx 9.8$ N. Drawing the free-body diagram, you have 100 N forward, 9.8 N backward (friction). Summing forces in the forward direction: $100 - 9.8 = 10 \times a$, so $a \approx 9.02$ m/s^2. Friction reduced what would have been a 10 m/s^2 acceleration (if frictionless) down to about 9 m/s^2. In an energy context, you might equate work to change in kinetic energy: that same 9.8 N friction force over some distance d would do $-9.8\,d$ Joules of work. If the sled travels 5 m, friction takes away $9.8 \times 5 = 49$ J of energy, which you'd subtract from the work done by the pulling force. No matter the approach, the contribution of friction is straightforward to include once you have F_k. Just remember it always *takes away* some motion (either by reducing acceleration or draining energy).

Check your results: A sanity check after solving a friction problem: Does the presence of friction make sense in your answer? With friction, accelerations should be **smaller** than they would be without friction, and required forces should be **larger**. If your answer suggests an object speeds up *more* with friction than without, or you needed less force to move an object on a rough surface than on a smooth one, that's a red flag. It likely means the friction force was mis-applied or given the wrong sign. Also check units: friction force in newtons or pounds-force should intuitively be less than the normal force for typical μ_k values. If you got a friction force greater than the weight of the object (and μ_k wasn't >1), double-check the arithmetic or unit conversion. By systematically considering μ_k, N, and direction, you'll avoid these pitfalls and confidently handle kinetic friction in any FE exam problem.

Topic 03 - Newton's Second Law for Particles

Topic Introduction: Newton's Second Law for particles is the backbone of dynamics problems on the FE Mechanical Exam. It connects **forces** and **motion** directly: whenever an object (modeled as a particle) accelerates, you can be sure that some net force is causing it. On exam day, you'll often face questions where you must sum up all forces (including weight, friction, tension, etc.) acting on an object and set that sum equal to ma to find an unknown acceleration or force. These questions can range from a simple one-dimensional push (e.g. finding the acceleration of a box when a certain force is applied) to two-dimensional motion (e.g. a crate sliding down an incline or a car rounding a curve, where forces must be resolved into components). The key to success is a solid grasp of Newton's second law and a systematic approach: draw a Free-Body Diagram (FBD), choose convenient axes (Cartesian x–y or path-aligned normal–tangential), and apply $\sum F = ma$ along each direction. In this chapter, we'll break down Newton's second law into three subtopics to master its use in **one- and two-dimensional motion**, in **normal/tangential vs. Cartesian coordinates**, and with proper inclusion of **weight ($W = mg$) and other forces**. By the end, you should be able to confidently set up and solve any particle dynamics problem by applying $\sum F = ma$ like second nature.

K07.T03.S01 – Application of $\sum F = ma$ for Particle Motion in One and Two Dimensions

- **Fundamental principle:** *Newton's Second Law* states that the net force acting on a particle equals the product of its mass and acceleration. In equation form: $\sum \mathbf{F} = m\mathbf{a}$. This holds true for motion in **any direction** – it's a vector equation that can be applied separately along each axis or dimension.
- **One-dimensional motion:** In a straight-line scenario, this simplifies to a single equation $F_{\text{net}} = ma$. For example, if a 10-kg cart experiences a net force of 50 N to the right, its acceleration will be $a = F_{\text{net}}/m = 50/10 = 5$ m/s^2 to the right. One-dimensional applications are straightforward: pick the positive direction (usually the direction of motion or intended motion), sum all forces in that line (taking care with signs for opposite directions), and set equal to ma to solve for the unknown.
- **Two-dimensional motion:** When forces (and acceleration) have components in two perpendicular directions (say x and y), Newton's second law applies *independently* to each direction: $\sum F_x = ma_x$ and $\sum F_y = ma_y$. This means you resolve forces into components and write separate equations for each axis. For instance, a projectile in flight has $\sum F_x = ma_x$ (often $= 0$ if no horizontal forces, meaning constant horizontal velocity) and $\sum F_y = ma_y$ (equal to $-mg$ if weight is the only vertical force, giving downward acceleration $-g$). The **vector form** $\sum \mathbf{F} = m\mathbf{a}$ is essentially a shorthand for these two (or three in 3D) component equations.
- **Choosing axes:** Always choose a convenient coordinate system so that as many forces as possible lie along your axes. For flat ground or free-fall problems, standard horizontal/vertical (Cartesian) axes work well. If an object is on an incline, it's often easiest to choose axes along and perpendicular to the incline (so that gravity mg needs to be split into components). Correct axis choice makes $\sum F = ma$ easier to apply because it minimizes how many forces need to be resolved into components.
- **Net force causes acceleration:** Remember that if the **net force is zero**, $ma = 0$ which implies $a = 0$ – the particle either remains at rest or moves with constant velocity (Newton's first law as a special case). Conversely, if a net force acts on the particle, it will accelerate in the direction of that net force. The larger the mass, the smaller the acceleration for the same force (mass is a measure of inertia, or "resistance" to acceleration). This intuitive point can guide you on exam day: e.g. a small object (low m) accelerates more easily than a massive object under the same push.

Equation Passport: Newton's Second Law (Particle) – relates the sum of applied forces on a particle to the resulting acceleration of that particle (use this to find acceleration from known forces, or required force to produce a desired acceleration).

Formal Equation (vector form): $\sum \mathbf{F} = m\,\mathbf{a}$

Variables and Units:

- $\sum \mathbf{F}$ – net force (vector sum of all external forces on the particle); units: N (SI) or lbf (US customary)
- m – mass of the particle; units: kg (SI) or slug (US customary) *Footnote:* 1 slug = 1 lbf·s²/ft
- $\mathbf{a}$ – acceleration of the particle (vector, same direction as $\sum \mathbf{F}$); units: m/s² (SI) or ft/s² (US)

Assumptions and Scope:

- Valid for a particle (object treated as a point mass, no rotation) with **constant mass** (no mass change with time).
- Applies in an **inertial frame** (i.e. a non-accelerating, non-rotating reference frame). If you're solving a problem from the ground's perspective (which is an inertial frame in most exam scenarios), you can apply $\sum F = ma$ directly. (In accelerating frames, pseudo-forces would be needed – but those situations are beyond the scope of the FE exam.)
- The equation assumes all relevant forces are included in $\sum \mathbf{F}$ – it does *not* automatically account for forces not in your free-body diagram, so be thorough in identifying forces.

Limit Tests (Sanity Checks):

- If $\sum \mathbf{F} = 0$, then $m\mathbf{a} = 0 \Longrightarrow \mathbf{a} = \mathbf{0}$. *Check:* No net force means no acceleration – the particle either stays at rest or moves at constant velocity. (This is a reassuring special case: Newton's second law correctly collapses to Newton's first law.)
- If $m \to \infty$ (very large mass) while $\sum \mathbf{F}$ is finite, then $\mathbf{a} \to \mathbf{0}$. *Check:* An extremely massive object won't accelerate perceptibly under a modest force (imagine pushing a freight train and barely budging it – huge m yields tiny a).

- If a constant force is applied and we let m shrink to a very small value, a becomes very large. *Check:* Tiny mass (like a ping-pong ball) reacts with a huge acceleration to even a small net force (it zips away), consistent with our expectations.

Use vs. Sibling Equations: Use $\sum F = ma$ for dynamics (when acceleration is present). In contrast, use the equilibrium condition $\sum F = 0$ when an object is not accelerating (statics scenarios). In other words, **don't** set $\sum F$ to zero if the problem implies acceleration – instead, set it equal to ma and solve. *(Sibling concepts:* In some problems, energy methods or impulse-momentum might also be applicable. However, Newton's second law is the direct method whenever forces and acceleration at an instant are involved. It is the go-to equation if you're dealing with forces causing linear acceleration, as opposed to, say, using $W = \Delta KE$ in work-energy methods.)

Common Exam Traps:

- **Missing a force:** A very common mistake is to forget to include all forces in the sum. Always draw a Free-Body Diagram and double-check you've included weight, normal forces, friction, tension, springs, thrust, etc., as applicable. For example, if a problem involves a sled tied to a rope, include both the rope tension and weight (and normal/friction if on a surface) in your force summation. Missing a force will give the wrong net force and wrong acceleration.
- **Sign convention errors:** You must consistently assign a positive direction. If you assume rightward (or upward) is positive, then forces to the left (or downward) should enter the sum with a minus sign. Many exam errors come from sign mistakes – for instance, writing $+mg$ instead of $-mg$ when summing forces upward for a vertically accelerating object. Keep track of your chosen positive direction with a small "+" on your FBD for clarity.
- **Confusing mass and weight:** Remember that mass m and weight W are related by $W = mg$, but they are not the same. If an object's mass is given in kilograms, do not multiply by 9.81 again when using $F = ma$ – use the mass as-is in ma. Conversely, if a **force** (like weight) is given in newtons or pounds, do not plug that in for m in ma. Always distinguish whether a given numeric value is a force or a mass before plugging into the equation.
- **Unit mix-ups:** Ensure that units are consistent. In SI units, use m in kg, a in m/s², yielding force in N. In US units, it's easiest to convert weight to mass in slugs when using $F = ma$. For example, a weight of 10 lbf corresponds to a mass of $10/32.174 \approx 0.311$ slugs. Alternatively, use $F = ma/g_c$ with $g_c = 32.174$ ft/s^2 if you keep m in lbm and F in lbf (more on that in footnotes). A common trap is forgetting g_c in US unit calculations, leading to an answer off by a factor of 32.2!

Exam Handbook Search Cues (Not affiliated with or endorsed by NCEES): "Newton's second law"; "particle kinetics"; "$\sum F = ma$"; "acceleration, force, mass"

Footnotes:

- *Units in US Customary:* In USCS units, the equation can be written as $F_{(\text{lbf})} = m_{(\text{lbm})} \times a_{(\text{ft/s}^2)}/g_c$ where $g_c = 32.174$ ft/s^2 is a conversion constant. This is because 1 lbf = 1 lbm × 32.174 ft/s². If you prefer, convert all masses to slugs (1 slug = 32.174 lbm) so that $F = m_{(\text{slug})} \times a$ works directly. On the exam, if you see forces in pounds (lbf) and masses in lbm, be ready to either apply g_c or convert units accordingly.

- *Mass vs. Weight:* Mass m (in kg or slug) is an inherent property of the object and doesn't change with location. Weight W (in N or lbf) is a force: it *does* change if gravity g changes (e.g., on the Moon). Newton's second law uses mass in ma; any weight force should be included as part of $\sum F$. (We will discuss weight specifically in a later subtopic.)

- *Scope:* Newton's second law is valid for **classical mechanics** at everyday speeds and sizes. You don't need to worry about relativistic or quantum effects on the FE – those are far beyond exam scope. Also, Newton's second law for rotation (which involves moments of inertia and angular acceleration) is handled separately in rigid body dynamics; here we focus on point masses (particles) moving linearly or along curves.

Variations, Related Forms, Typical Values:

- **Component form:** $\sum F_x = ma_x$, $\sum F_y = ma_y$, $\sum F_z = ma_z$ (if 3D). Use these to solve multi-direction problems by treating each direction independently. It's typical in FE problems to align one axis with the direction of acceleration to simplify calculations (e.g., for a block on a 30° incline, align x-axis along the incline so that acceleration is purely along x).

- **Weight as a specific force:** A common particular case is vertical motion under gravity. There, $\sum F_y = ma_y$ might become $-W +$ (other upward forces) $= ma_y$ if we take upward as positive. If weight is the only force (free fall), $\sum F_y = -mg = ma_y$ giving $a_y = -g$ (downward acceleration of 9.81 m/s^2).

- **Special case – equilibrium:** If a problem states or implies constant velocity or no motion, set $a = 0$ in $\sum F = ma$. This yields $\sum F = 0$, recovering the static or kinetic equilibrium condition. Many exam problems sneakily test if you recognize a = 0 (so that all forces must cancel out).

- **Typical magnitudes:** Accelerations in everyday mechanics problems might range from a few m/s^2 (for vehicles or elevators) up to perhaps dozens of m/s^2 in more extreme cases. If you calculate an acceleration like 1000 m/s^2 for a car, that's likely a mistake – use such intuition to double-check your work. Likewise, net forces usually come out in the manageable range (tens to thousands of newtons, or pounds) for exam-sized scenarios – if you get an outrageously large or tiny force, reconsider your setup.

Special Notes – Calculator: Newton's second law calculations are usually straightforward for your FE-approved calculator. Just be cautious with unit conversions. If you're working a problem in US units, you might do something like m = 1500/32.174 to convert a 1500 lbf weight to slugs, then compute F = m * a. If you prefer using g_c, you could input the formula as given. For example, on a TI-36X Pro, you might enter: F = (m * a) / 32.174 if m is in lbm and a in ft/s² to get F in lbf. Always include parentheses appropriately – e.g. (m * a) / 32.174. In SI units, no special considerations are needed beyond using the × and / keys normally (e.g. entering F = 1000 * 3.5 to get 3500 N for a 1000-kg object accelerating at 3.5 m/s^2). In short, the calculators handle $F = ma$ easily; just make sure *you* handle the units correctly before plugging in numbers.

Explanation & Analysis (Step-by-Step): Newton's second law is **the tool** for translating a physical situation into a mathematical model when acceleration is involved. Here's how you typically apply it on the FE exam:

1. **Identify the "particle" and sketch a Free-Body Diagram (FBD):** Even if a diagram isn't provided, take a moment to imagine or sketch the object in question and all forces acting on it. Treat the object as a point mass (draw it as a dot or a simple box) and draw arrows for each force: e.g. weight $W = mg$ downward, normal force N from surfaces, friction f opposing motion, tension T in ropes, thrust, drag, etc. Label each force with its symbol and magnitude if known (or leave as variable if unknown). This visual **clarifies what forces to sum up** and in which directions they act. For example, if analyzing a sled on an incline, your FBD would show weight downward, normal perpendicular to the slope, and perhaps friction along the slope. Each arrow on the FBD is a term that will go into $\sum F$. *(Many students who rush into equations miss a force; the FBD is your insurance policy!)*

2. **Establish a coordinate system:** Decide which direction to call positive for **each axis**. In one-dimensional cases, this is as simple as "I'll take upward as positive y" or "along the incline as $+x$ direction of motion." In two dimensions, set up perpendicular axes (e.g. an x–y Cartesian grid, or sometimes tilt axes to align with motion as in the incline case). Mark these axes on your diagram, including arrows to indicate positive directions. This step is vital for consistency: once chosen, stick to those positive directions when writing force components and acceleration. If you choose rightward and upward as positive, then gravitational force might be $-mg$ (negative y direction) in your equations. Choosing convenient axes (e.g. one axis along the direction of acceleration) can simplify the math and minimize the number of components.

3. **Resolve forces into components (if 2D):** For any force not aligned with your axes, break it into components that are. For instance, the weight $W = mg$ of an object on a 30° incline can be resolved into a component $mg\sin(30°)$ down the slope and $mg\cos(30°)$ perpendicular to the slope. Do this for each angled force. Draw these components on the diagram or compute them directly, and be mindful of their signs (based on your axes). On the exam, often one or two forces will need such resolution – typically weight on an incline or perhaps a push at an angle.

4. **Write $\sum F = ma$ for each axis:** Now translate the FBD into equations. For the x-direction (say horizontal or along the incline), sum of forces $\sum F_x$ = (add **positive** forces in the $+x$ direction) $-$ (subtract forces in the $-x$ direction) = ma_x. Do the same for the y-direction: $\sum F_y = ma_y$. Each equation should include **all** force components along that axis from your FBD. For example, for a box on a rough incline, you might write along the incline: $mg\sin!\,\theta - f_{\text{fric}} = ma_x$ (taking down-slope as positive x), and perpendicular to incline: $N - mg\cos!\,\theta = ma_y$. Often one direction will have no acceleration (e.g. no motion perpendicular to a surface), so $a_y = 0$ and that equation simplifies to an equilibrium condition ($N = mg\cos!\,\theta$ in this case). The other direction's equation will then give the acceleration or the unknown force. Always double-check the signs: if you get a negative value for acceleration from your chosen positive direction, it simply means the acceleration is opposite to what you assumed (the math is fine—you just interpret it accordingly).

5. **Solve for the target quantity:** With the $\sum F = ma$ equations written, solve them for the unknown. This might be the acceleration a (if forces are known) or an unknown force (if acceleration or velocity info is given). For example, if a problem says "A 10-kg cart is pushed with 30 N across a level surface with 5 N of friction. What is its acceleration?", your equation (taking forward as $+x$) would be $\sum F_x = 30\text{ N} - 5\text{ N} = 10\text{ kg} \cdot a_x$. That gives $25\text{ N} = 10\text{ kg} \cdot a_x$, so $a_x = 2.5\text{ m/s}^2$. On the other hand, if a problem gives a required acceleration and asks for a force (a common scenario for design-type questions: "what force is needed to accelerate..."), you rearrange $F = ma$ as $F = m \times a$ to find the net force required, then consider what real forces would sum to that. (E.g., to accelerate a 1500 kg car at 3 m/s^2, you'd need net $F = 1500 \times 3 = 4500$ N pushing it forward – provided by the engine drive force minus any resistances.)

6. **Check results for consistency:** After solving, do a quick mental check. Does the sign of your answer make sense (e.g. acceleration direction, or that a normal force came out positive)? Are the magnitudes reasonable? If you got an acceleration larger than $g = 9.81\text{ m/s}^2$ in a simple mechanics problem, pause and think – is that plausible or did you perhaps miss a force? Likewise, if your computed tension in a rope is zero or enormous, recheck the FBD and equations. Consistency checks like these can catch mistakes in exam conditions when a full re-derivation might not be feasible.

By following these steps, you're effectively using Newton's second law as a **recipe** to solve particle dynamics problems: *free-body diagram → resolve forces → apply $\sum F = ma$ → solve*. With practice, it becomes a quick, almost reflexive process. Many FE problems are designed to see if you set up $\sum F = ma$ correctly; the actual number crunching is usually straightforward once the equation is right. Focus your effort on the setup – that's where most errors occur. And remember, Newton's second law is conceptually simple: **push harder → accelerate faster** (for the same mass), **heavier object → accelerates slower** (for the same net force). Keep that intuition in mind, use it to double-check your work, and you'll navigate these questions with confidence.

K07.T03.S02 – Solving Dynamics Problems in Normal–Tangential Coordinates or Cartesian Coordinates Using $F = ma$

- **When to use different coordinate systems:** Newton's second law $\sum F = ma$ is true in *any* coordinate system, but choosing the right one makes solving problems much easier. You have two common choices: **Cartesian coordinates** (traditional x–y axes, or x–y–z in 3D) vs. **Normal–Tangential (n–t) coordinates** (axes that follow the particle's path). For straight-line motion, Cartesian is usually simplest. For curvilinear motion (object moving along a curved path, like a car taking a turn or a rollercoaster on a hill), normal–tangential coordinates often simplify the analysis because one axis (tangential)

points along the motion and the other (normal) points toward the center of curvature.

- **Cartesian (x–y) approach:** You resolve all forces into horizontal and vertical components and apply $\sum F_x = ma_x$, $\sum F_y = ma_y$. This approach is universal – you can always fall back on it – but for some curving motions it leads to mixed effects (e.g. centripetal force components). For example, analyzing a car on a banked curve in pure x–y axes can be cumbersome, because the acceleration is centripetal (pointing toward the center of the turn, which is neither purely horizontal nor vertical if the road is banked).
- **Normal–Tangential (n–t) approach:** Here you choose axes that move with the particle: the **tangential (t) direction** is along the path (in the direction of velocity), and the **normal (n) direction** is perpendicular to the path, pointing toward the center of curvature (the instantaneous center of the "turn"). Newton's second law splits neatly into $\sum F_t = ma_t$ and $\sum F_n = ma_n$. The big advantage is that **a_n and a_t have known interpretations:** a_t represents change in speed (tangential acceleration) and a_n represents change in direction (centripetal acceleration). Specifically,

  $a_t = \frac{dv}{dt}$ – the rate of change of the particle's speed along the path (this can be positive if the particle is speeding up along the path, negative if slowing down).

  $a_n = \frac{v^2}{R}$ – the centripetal (normal) acceleration required to follow the curved path, pointing toward the center of curvature. Here v is the instantaneous speed and R is the radius of curvature of the path at that point. Even if the speed is constant, if the path is curved ($R < \infty$), there is a nonzero a_n pointing inward. Conversely, if the path is straight (infinite radius), $a_n = 0$.
- **Using $F = ma$ in n–t coordinates:** The tangential equation $\sum F_t = ma_t$ relates the component of net force along the direction of motion to the change in speed. This is where engine thrust or friction along the motion comes into play. For instance, on a roller coaster, the tangential component of gravity might make it speed up or slow down along the track (downhill or uphill). The normal equation $\sum F_n = ma_n$ relates the net inward force to the centripetal requirement mv^2/R. This often involves forces like friction or normal forces providing the centripetal push. For example, for a car turning on a flat road, the frictional force toward the center of the turn provides F_n, and you'd set $F_{\text{friction}} = mv^2/R$ to find either the max speed (before friction is insufficient) or the required friction force. In a vertical circle (like a pendulum or a roller coaster loop), $\sum F_n = mv^2/R$ might involve the difference between tension/normal force and weight (because weight may partially provide or oppose the centripetal force depending on orientation).
- **Planar curvilinear motion:** Normal–tangential axes are most useful for **plane curvilinear motion** (motion along a 2D curve). They simplify problems where the motion path is known or constrained (e.g., circular motion, cars on curves, objects attached to rods or ropes moving in arcs). In such cases, you often directly know or need v^2/R somewhere in the calculation. On the flip side, if a problem doesn't inherently involve a curved path or if it gives a_x and a_y directly, stick with Cartesian. The exam may sometimes nudge you toward n–t by mentioning terms like "normal force toward the center needed for circular motion" or giving you a curve radius. Take that as a cue to use $\sum F_n = mv^2/R$.
- **Interpreting the forces and acceleration:** In any coordinate system, the physical laws are the same – but a well-chosen coordinate system turns a complex vector problem into simpler scalar equations. If you use n–t, remember: the normal direction handles the centripetal "turning" aspect (anytime an object curves, ask "what's pushing it inward?"), and the tangential direction handles the speeding up or slowing down. In Cartesian, you'll often find yourself computing components of these anyway. So choosing n–t is like aligning with nature's way: one equation for speeding up/slowing down, one for turning.

Equation Passport: Normal–Tangential Form of Newton's Second Law – resolves the net force and acceleration into the particle's path directions, **tangential (t)** for along-path (changing speed) and **normal (n)** for perpendicular to path (changing direction/curvature). Use this form instead of Cartesian when an object is following a curved path – it directly handles centripetal force requirements.

Formal Equations: $\sum F_t = m\,a_t$, $\quad \sum F_n = m\,a_n$.

Variables and Units:

- $\sum F_t$ – net force component along the tangent to the path (points in the direction of motion if speeding up, opposite if slowing down); units: N (SI) or lbf (US)
- $\sum F_n$ – net force component in the normal direction (pointing toward center of curvature of the path); units: N or lbf
- m – mass of the particle; units: kg or slug
- a_t – tangential acceleration (rate of change of speed); units: m/s² or ft/s². By definition, $a_t = \frac{dv}{dt}$, where v is the speed along the path. a_t is positive when the particle is gaining speed moving forward, negative when braking/losing speed.
- a_n – normal (centripetal) acceleration (rate of change of velocity direction); units: m/s² or ft/s². Magnitude given by $a_n = \frac{v^2}{R}$, pointing toward the instantaneous center of curvature (inward). Here R is the radius of curvature of the path at that point (in meters or feet), and v is the instantaneous speed (m/s or ft/s).
- R – radius of curvature of the path (sometimes denoted ρ in textbooks); units: m or ft. (If the path is a circle, R is just the circle's radius. If path is general curve, R might change from point to point.)
- v – speed of the particle along the path at the instant considered; units: m/s or ft/s.

Assumptions and Scope:

- Motion is confined to a plane (2D curve) so that a single normal–tangential pair of axes suffices. (For full 3D motion, one might use a normal-binormal-tangential coordinate system, but that complexity is beyond FE exam scope.)
- The path curvature is well-defined (smooth curve). We assume the radius of curvature R is either given, or can be

determined from geometry or provided data (e.g., "a car goes around a curve of 50 m radius").

- $a_n = v^2/R$ formula assumes **constant speed over an infinitesimal interval** – effectively it comes from centripetal acceleration formula for circular motion. If v is changing, a_n is still computed with the instantaneous v (since centripetal acceleration at any moment depends on speed at that moment). This is valid as long as v is not changing so wildly that the curvature itself changes during the analysis – typically not an issue in exam problems.
- Axes n and t are **moving with the particle**, constantly rotating to stay aligned with velocity. Newton's second law still applies instantaneously in this rotating coordinate system because we consider only the instantaneous acceleration components. (A full rotating reference frame treatment would involve pseudo-forces, but here n–t axes are attached to the moving particle, not a rotating frame origin – so you can safely use $\sum F = ma$ along n and t at a given instant.)

Limit Tests:

- **Straight-line motion:** If the path is straight (imagine $R \to \infty$), then $a_n = v^2/R \to 0$. The normal equation $\sum F_n = ma_n$ then just gives $\sum F_n = 0$ (since $a_n = 0$), meaning no net sideways force is needed for straight motion – which makes sense. The tangential equation remains $\sum F_t = ma_t$, same as a usual one-dimensional $F = ma$ along the line. This shows that n–t coordinates smoothly revert to regular 1D motion in the special case of a straight path.
- **Uniform circular motion:** If speed v is constant (so $a_t = 0$) but the particle is going in a circle of radius R, then $\sum F_t = 0$ (no net force along motion, consistent with constant speed) and $\sum F_n = m\frac{v^2}{R}$ (net inward force of magnitude mv^2/R is required to keep turning). If you accidentally got a nonzero $\sum F_t$ in a constant-speed circle scenario, that would be a red flag. Similarly, if you calculated a_n and it wasn't equal to $\sum F_n/m$, something's off.
- **Zero curvature (flat path) vs. zero speed:** Two distinct cases: If $R \to \infty$ (flat path), as mentioned, $a_n \to 0$. If $v = 0$ (the particle is momentarily stopped but perhaps about to move), $a_n = 0$ as well (no centripetal acceleration when no motion). But be careful: if the particle is at rest *and* going to remain at rest, then also $a_t = 0$ and all forces must balance to zero – that's a static case. If it's at rest but about to start moving (like a car at the apex of a hill momentarily with zero vertical speed), you might still compute a curvature at that point if it's going over a hill (gravity and normal might not cancel at that instant because it's in the transition). Usually, exam problems avoid such fine distinctions and stick to either steady motion or clearly defined changes.

Use vs. Sibling Equations: Use n–t form instead of plain x–y components when the problem's geometry screams "circular motion" or "curved path." For example, **use $\sum F_n = mv^2/R$ rather than resolving forces into x and y** when dealing with centripetal force scenarios like a car on a curve, a mass on a string whirling in a circle, or an object in a vertical loop. The n–t form essentially **is** Newton's second law, just rotated to align with motion – it's not a new equation, but a convenient reorientation of $\sum F = ma$. If you're torn between methods, remember: *all roads lead to Rome* (Cartesian or n–t both work), but one might be a shortcut. You won't be *wrong* using x–y, but you might have to solve simultaneous equations or trigonometry that the n–t approach bypasses.

Common Exam Traps:

- **Forgetting centripetal direction:** When using n–t, it's easy to mix up which force goes into which equation. Always identify: which forces act **toward the center of the curve**? Those belong in $\sum F_n$. Which forces act along the path (forward or backward along direction of motion)? Those go in $\sum F_t$. For example, consider a car turning left on a flat road. The frictional force from the ground on the tires is directed toward the left (inward toward the turn center) – that is a normal direction force providing mv^2/R. The engine force (if speeding up) or air drag (if slowing down) acts along the direction of motion (tangential). If you accidentally put weight or engine force into the normal sum, you'll get nonsense. Keep the categories straight.
- **Sign conventions in n–t:** Typically, we take $a_n = +v^2/R$ inward. So you should treat forces toward the center as positive in $\sum F_n$. If you get a negative $\sum F_n$ result, it could mean the net force is actually outward (which would imply the chosen scenario needs re-examining – e.g. you assumed a tight turn but maybe the car can't make it and is skidding outward?). In most cases, one expects $\sum F_n$ to come out positive inward. For tangential, you decide a positive direction (usually the direction of motion as $+t$). So if the object is slowing down, $\sum F_t$ will be negative (net force opposite to motion). That negative result is fine – it indicates braking. A common mistake is to plug values without the sign and lose that information. Always attach a sign: e.g. if friction is slowing the object, and you took forward as positive, then F_{friction} in the tangential sum is a negative number.
- **Using the wrong v or R:** Make sure you use the instantaneous speed at the moment of interest. For instance, if a problem says "at the lowest point of the swing, the speed is 5 m/s, find the tension in the string," use that $v = 5$ and the radius equal to the string length in $\sum F_n = mv^2/R$. Sometimes exam problems involve changing speed – if you're asked for centripetal force at a certain point, use the speed at that point, not the initial or final speed elsewhere. And ensure radius is in consistent units with speed. If v is given in km/h, convert to m/s before computing v^2/R in SI units.
- **Over-complicating straight motion:** Occasionally, students might mistakenly try to use n–t for a straight-line acceleration problem. This isn't wrong (it will reduce to the same thing with $a_n = 0$), but it's unnecessary work. If the motion is along a straight line (no curvature), stick to a single-axis $F = ma$. Reserve n–t for when a clear curve or rotation is involved.

Exam Handbook Search Cues (Not affiliated with or endorsed by NCEES): "normal and tangential"; "curvilinear motion"; "$a_n = v^2/R$"; "$a_t = dv/dt$"; "centripetal force"

Footnotes:

- *Alternate notation:* Some sources use a_c (centripetal acceleration) instead of a_n, and F_c for centripetal force (the net inward force). In the exam reference handbook, the term "Normal and Tangential kinetics" is used, and the formula appears as shown. Just be aware a_n (normal) = a_c and $\sum F_n$ is sometimes called F_c. The direction toward the center might also be called "radial" (especially in polar coordinates, using r–θ components). In the context of a circular path, "radial" and "normal" are the same (pointing to center).

- *Radius vs. curvature:* If given a curvature κ (kappa) instead of radius, recall that $\kappa = 1/R$. But in most FE problems, you'll get radius directly (e.g. curve of radius 50 m) or be dealing with nice shapes like circles or corners.

- *Dynamics vs. kinematics:* The normal–tangential formulas combine motion and force. There are pure kinematics formulas that relate a_t and a_n without forces (like $a_n = v^2/R$ is kinematic). Ensure you tie forces to these accelerations via $\sum F = ma$ when appropriate. It's possible to compute a_n from motion data (speed & radius) and then use that to find a force (e.g. required friction = ma_n). This two-step thinking (find a from kinematics, then force from $F = ma$) is often tested.

- *Banked curves:* A classic application is a vehicle on a banked turn. Using n–t coordinates, you align t along the slope of the banking (tangent to path) and n horizontally inward. Then $\sum F_n = mv^2/R$ often involves a component of normal force and possibly friction. The analysis is simplified by n–t axes, but just remember: gravity has to be resolved into these axes (it will have components in both $-n$ and $-t$ directions if the road is banked). Keep track of that if a banked curve problem appears.

Variations, Related Forms, Typical Values:

- **Cylindrical coordinates (alternate to n–t):** Sometimes problems are given in terms of radial and tangential components (especially if something is rotating about a fixed axis or in polar coordinates). Cylindrical (r, θ) coordinates yield similar formulas: $\sum F_r = m(\ddot{r} - r\dot{\theta}^2)$ and $\sum F_\theta = m(r\ddot{\theta} + 2\dot{r}\dot{\theta})$, which are more general (including non-uniform circular motion and moving radius). This is **beyond the typical FE scope** unless you specifically study mechanical vibrations or orbital motion. The FE Mechanical usually sticks to either straight-line or constant-radius scenarios that the simpler n–t handles. So you likely won't need the full general polar form, but it's good to know that n–t (with R constant) is a simplified case of those formulas.

- **Typical values:** Centripetal accelerations can be surprisingly high even at moderate speeds if radius is small. For example, a car going 13.4 m/s (30 mph) around a 10 m radius turn has $a_n = v^2/R \approx$ 18 m/s^2, which is about 1.8 g – quite a lot of acceleration requiring strong friction. Be mindful of realistic limits: if you compute a required friction coefficient > 1, that means the turn cannot be made without skidding (or banking). The exam might expect you to notice an unphysical result like that as a clue (or just accept it as "skidding occurs"). Normal accelerations much larger than g (9.81 m/s²) often occur in machines, centrifuges, etc., but for vehicles and small-scale systems you generally expect a_n on the order of 0–5 g in problems.

- **Relative directions:** If the problem provides acceleration components in x–y, you can always convert: If you know a_x and a_y, and you realize the motion is curvilinear, you can find a_t and a_n by projecting onto velocity direction. Usually not necessary for exam, as they won't force a transform – they'll hint to use one approach or the other.

- **Cornering and circular motion formulas:** A useful related formula: $\mu_{\text{centripetal}} = \frac{v^2}{Rg}$ – this is the minimum coefficient of friction needed for a flat road turn without skidding (comes from $F_{\text{friction}} = mv^2/R$ and $F_{\text{friction}} \leq \mu N = \mu mg$). It's not given explicitly in the handbook, but it's a quick derivation with n–t application. If you see a problem asking for maximum speed in a turn given μ, this relation is handy. Typical safe turn coefficients are around 0.1–0.3 for wet roads, up to 0.8 for dry. So if you calculate $\mu > 1$ required, you know it's impossible without banking.

Special Notes – Calculator: The main calculation difference in n–t problems is the presence of a **square** (in $a_n = v^2/R$) and sometimes a square-root if solving for v. All FE-approved calculators can handle these easily, but be careful with input format. For example, if solving $m\frac{v^2}{R}$ for v, you'll do $v = \sqrt{\frac{\sum F_n R}{m}}$. On a TI-30 or Casio, you'd type the inside of the sqrt first, then apply the square root. A common mistake is to forget parentheses: $\sqrt{\sum F_n * R/m}$ should be entered as something like sqrt((F_n * R) / m). Another tip: if you have v^2/R to compute, it might be safer to compute v^2 first, then divide by R, especially if v is given or easily squared. (All those calculators have an x^2 button, which can minimize mistakes vs. typing $v * v$.) Also, if v is given in km/h or another unit, convert to m/s **before squaring** to avoid unit issues. The calculator won't know to convert units for you, of course. In summary, no special calculator functions are needed beyond square and square root – just use them carefully and double-check that you square the speed and not accidentally the whole right side or something silly. And as always, keep track of units outside the calculator; the numeric input to v^2/R must be in consistent units.

Explanation & Analysis (Step-by-Step): Let's walk through applying Newton's second law in normal–tangential coordinates with a typical scenario: **a car taking a turn**. Suppose a car of mass m is moving at speed v around a curve of radius R. We want to find, say, the friction force required to keep it on track (no slipping). Here's how we'd proceed:

7. **Visualize and choose n–t axes:** Draw the car as a dot on the curve. The velocity **v** is tangent to the path (pointing along the road). We set the tangential direction t along **v** (direction the car is moving) and the normal direction n pointing toward the center of the curve (perpendicular to v, inward). Label the center of the curve (imagine a circle center if the road is part of a circle). The car is essentially going in a circular arc, so we know it needs a centripetal (inward) force. Mark $+n$ toward the center and $+t$ in the direction of motion. For a flat turn with no speeding up or slowing down, we expect $a_t = 0$ and $a_n = v^2/R$ inward.

8. **Identify forces and FBD in n–t components:** What forces act on the car? Gravity $W = mg$ (which acts downward, not along either n or t – we'll handle that in a moment), the normal force N from the road (acts perpendicular to road, which on flat ground is straight up, opposite weight), friction f between tires and road (this is the key force that can have a component toward the center or along the motion depending on if the car is turning or speeding/braking). In this pure turning scenario, assume speed is constant, so friction is directed inward (static friction towards center provides centripetal force) but not forward/backward since no acceleration along the road. Draw the friction force arrow toward the center of the turn (sideways friction) on the car's dot. Draw weight downward and normal upward (they cancel

each other in vertical since the car isn't flying or sinking – that's separate z axis equilibrium in this 3D situation). Now, translate these forces into the n–t axes. The friction force is already along the $+n$ axis (inward), great. The weight and normal are vertical; they are perpendicular to the horizontal road, which in our n–t picture is out-of-plane (if we consider t–n plane is horizontal). In pure horizontal turn, W and N don't have n or t components (they act in the z direction). So in the n–t plane, the only force contributing to n or t components is friction. (If the car was also accelerating forward or if the road was banked, we'd have tangential friction or components of gravity to consider. But let's keep it simple.) Summaries: $\sum F_t$ (along motion) has no forces because speed is constant (engine thrust = drag maybe, but if constant speed, they cancel out, net zero). $\sum F_n$ (inward) has the friction force f inward.

9. **Write n–t equations:** Tangential: $\sum F_t = ma_t$. Here $\sum F_t = 0$ (no net force along motion, as we established), so $0 = ma_t$. Thus $a_t = 0$ as expected (consistent with constant speed). Normal: $\sum F_n = ma_n$. Here $\sum F_n = f_{\text{inward}}$ (friction toward center; let's call its magnitude F_f for friction force). So we have $F_f = ma_n$. But $a_n = v^2/R$. So this becomes $\boldsymbol{F}_f = m\frac{v^2}{R}$. This is a powerful relationship: it directly tells us the friction force required to turn the car at speed v on radius R.

10. **Solve or interpret:** If the problem asked for friction force, we now have it: $F_f = mv^2/R$. If it asked for the minimum coefficient of friction μ to avoid slipping, we'd set $F_f \leq \mu N$. Here $N = mg$ (since weight equals normal on flat ground), so $mv^2/R \leq \mu mg$. Simplify that to $\cancel{m}v^2/R \leq \mu g$, or $\mu \geq v^2/(Rg)$ for safe turning. That result might be the target of a conceptual question (like "given a curve radius and speed, what road friction is needed?"). If the number comes out larger than available μ, it means skid. If the problem gave numerical values, we'd plug them in at this stage to get a number for F_f or μ.

11. **Check directions and special cases:** We assumed the car wasn't accelerating forward, only turning. Our equations reflected that ($a_t = 0$). If instead the car was also speeding up *while* turning (a more complex scenario), friction would have to supply a component along t as well. You'd then have $\sum F_t = ma_t = m\dot{v}$ and $\sum F_n = mv^2/R$ simultaneously, with friction vector splitting into two components to handle both. That's a bit more advanced but follows the same principle: split friction into a forward component and a sideways component. The magnitude of friction has an upper limit μN, and if the required vector sum exceeds that, again, the car would skid (either slip forward or outward or a combination). The FE exam might break such a scenario into parts or neglect the interplay (they usually keep it simpler: one direction of acceleration at a time). Regardless, by choosing n–t axes, you handle each component of acceleration with clarity.

12. **Example of when Cartesian would be messier:** If we tried the above in x–y (north/east or something), we'd have to pick an orientation. Say x axis toward the center of turn, y axis forward along the car's motion. Then friction is along x (good), but then the car's acceleration vector has components $a_x = v^2/R$ (toward center) and $a_y = 0$. We could do $F_x = ma_x$, $F_y = ma_y$ and get the same result. Actually, in this simple case it's equally fine. But if the road were banked, N would tilt and have components in both x and y that you'd include; that's where n–t truly shines by aligning with the motion plane. The moral: Cartesian can always work, but n–t aligns with the natural physics of curvilinear motion and often saves steps.

In summary, solving dynamics problems in normal–tangential coordinates is about **aligning your axes with the motion** – one axis points along the motion (handling speeding up/slowing down), and one points toward the center of curvature (handling turning forces). It streamlines problems where curvature is involved. The FE exam expects you to recognize these scenarios and apply $\sum F = ma$ accordingly. It's satisfying too: plug in numbers to mv^2/R and immediately see if that centripetal force is feasible or not, or find what you need to provide it (friction, tension, etc.). With practice, you'll know when to go x–y and when to go n–t. When in doubt, visualize the path of motion – if it's a straight line, stick to straight components; if it's a curve, consider riding along with the particle and use normal–tangential to make your life easier.

K07.T03.S03 – Incorporating Weight ($W = mg$) and Other Forces into Equations of Motion for Particles

- **Weight as a force in dynamics:** Weight ($W = mg$) is the force of gravity acting on a mass. For any object near Earth's surface, weight points **downward** (toward Earth's center). When applying $\sum F = ma$, it's crucial to include weight among the forces if the vertical direction is involved. Many FE problems involve gravity either directly (objects in vertical motion, projectiles, pendulums) or indirectly (objects on inclines, where weight's component drives motion). Always distinguish between an object's **mass** (in kilograms or slugs) and its **weight** (in newtons or pounds-force). The weight provides a specific contribution to $\sum F$: typically $-mg$ in the vertical $\sum F_y$ if we take upward as positive.
- **Common forces in particle motion:** Besides weight, other forces you'll routinely incorporate are: **normal forces** (contact forces from surfaces, perpendicular to the surface), **frictional forces** (parallel to surfaces, opposing relative motion, with magnitude $f = \mu N$ at maximum static or $f_k = \mu_k N$ if sliding), **tension** in ropes/cables (pulling force along the rope, always pulling away from the object), **spring force** (proportional to displacement, $F_s = kx$ usually, pulling or pushing toward equilibrium length), **applied pushes or pulls**, **buoyant forces** (if submerged in fluid, equal to weight of displaced fluid), and so on. In $\sum F = ma$, *every* force acting on the particle must appear in the sum, with its proper direction. Newton's second law doesn't know what the source of force is – it just knows that all those force vectors together determine ma. So your job is to ensure no force is left out.

Incorporating weight in various situations:

- **Vertical motion (lift, elevator, free-fall):** If an object moves vertically, weight plays a central role. Take upward as positive (often convenient). Then weight is $W = mg$ downward, so in your equation it enters as

$-W = -mg$. For example, a 70 kg person in an elevator accelerating upward at 2 m/s^2: the forces on them are the normal force N upward (what the scale would read as "apparent weight") and weight mg downward. Sum of forces: $N - mg = ma$. Plugging numbers: $N - (70 \times 9.81) = 70 \times 2$. Solve: $N = 70(9.81 + 2) = 70 \times 11.81 = 826.7$ N. That N is greater than mg (which is 686.7 N) – meaning they feel heavier due to upward acceleration. If the elevator were accelerating *downward* at 2 m/s^2, the equation would be $N - mg = 70 \times (-2)$ (because acceleration is downward, -2 in our upward-positive sign convention). That yields $N = 70(9.81 - 2) = 548.7$ N, less than their actual weight – they feel lighter. This is a classic application: understanding "apparent weight" as $N = m(g \pm a)$. The key is correctly including the weight (with sign) in $\sum F$.

- **Inclined planes:** On an incline of angle θ, weight mg acts vertically down. To use $F = ma$ along the incline, resolve weight into components: a component into the plane ($mg\cos\theta$, which is balanced by the normal force if no vertical acceleration through the plane) and a component down along the plane ($mg\sin\theta$). If the object slides down, $\sum F_{\text{along}} = mg\sin\theta - f_{\text{fric}} = ma$. If friction or other forces (push/pull) are present, include them with appropriate sign. The weight component $mg\sin\theta$ is what makes things accelerate down slopes – larger angle means larger fraction of weight pulling it down. If $\theta = 0$ (flat), $\sin\theta = 0$ – weight doesn't pull along the surface (no acceleration from gravity along horizontal, as expected). If $\theta = 90°$ (vertical free-fall), $\sin 90° = 1$ and mg fully acts to accelerate the object (just free-fall $a = g$).
- **Projectiles and free-fall:** In projectile motion (no propulsion, just gravity acting after launch), the only force (neglecting air resistance) is weight mg downward. So $\sum F_x = 0$ (no horizontal force, hence constant horizontal velocity) and $\sum F_y = -mg = ma_y$ giving $a_y = -g$. This yields the familiar -9.81 m/s^2 vertical acceleration for any object in free flight, regardless of mass (heavy or light, they fall with the same g in a vacuum – a direct consequence of $a = F/m = mg/m = g$). The exam might have you use this in questions about drop time, projectile range, etc., which is more kinematics, but the dynamics perspective is simply weight is the net force causing that acceleration.
- **Multiple forces and Newton's second law:** Consider a more complex situation: a sled (mass m) is pulled on level ground with a rope at some angle, including friction. The forces: weight mg (down), normal N (up), tension T in rope (say pulling up and right), friction f (left, opposing motion if sled's moving right). In vertical direction: $N + T_y - mg = 0$ if no vertical acceleration (so you can find N here, reduced by the T_y component). In horizontal: $T_x - f = ma_x$. Here weight doesn't appear in the horizontal equation at all (except indirectly affecting f via N). This shows a point: include weight in whichever equation (vertical or along a plane) where it has a component. Don't insert mg where it doesn't act. Many mistakes come from either forgetting to include weight where it matters, **or including it where it doesn't** (e.g. putting mg into a horizontal force sum unnecessarily). Always ask: does gravity have a component along my axis? If yes, include mg component; if no, don't force it in.
- **Other forces nuances:** Each type of force has its own character: **Normal forces** adjust themselves to whatever value needed to prevent interpenetration between surfaces (up to failure, like if something would lift off or break contact, N could go to zero). So sometimes $N = mg$ (flat ground), sometimes $N = mg\cos\theta$ (incline), sometimes $N = mg - F_{\text{other vertical}}$ (like an object pressed down or pulled up). Normal force is whatever it takes to support the object's motion constraint *without acceleration perpendicular to surface*, unless that constraint is broken. **Friction** is trickier: static friction $f_s \leq \mu_s N$ can vary up to a max; kinetic $f_k = \mu_k N$ has a fixed magnitude when sliding. On the exam, if an object "slides" they'll typically either give μ_k or have you compute acceleration with that; if it's "just about to slide" or "minimum force to start motion," that's static friction at its max $\mu_s N$. Friction always opposes relative motion (or impending motion). When summing forces, friction's direction might not be obvious initially – if unsure, assume a direction and if you get a negative value for f, it means the friction actually acted opposite to what you assumed. **Tension** in a rope always pulls along the rope, away from the object. If multiple objects are connected by ropes, tensions transmit forces between them (common in dynamics with pulleys, etc. – include tension in each object's FBD). **Spring force** $F_s = kx$ (or $k\Delta x$) acts opposite to displacement from equilibrium: if stretched, it pulls back; if compressed, it pushes outward. When using $F = ma$, if a spring is attached, include its force with the proper sign (if the spring is trying to slow the object, that force is opposite motion).
- **Sign convention with weight and others:** Often, taking upward as positive and rightward as positive works well. In that case, weight is usually $-mg$ in your equations (because it's downward). Normal forces on horizontal surfaces would be $+N$ (upward). On an incline axis along the slope, if you take downward along slope as positive, weight's along-slope component is $+mg\sin\theta$ (since it points down-slope), and friction (if resisting downward motion) would be $-f$. If instead the object is being pulled up the slope and you take up-slope as positive, then weight's component along slope is $-mg\sin\theta$ (since it's opposite your positive direction). The key: **consistently apply signs**. Weight will almost always contribute a negative term in an equation if you choose axes where "up or upward along a plane" is positive, since gravity points downward.
- **Frequent pitfalls:** (We'll enumerate in traps below, but to highlight) a big one is confusion between W and m as mentioned – especially in $F = ma$ problems, sometimes exam takers plug 9.81 for a and m as weight again incorrectly. Another is forgetting that weight acts even if something is not moving vertically – it still may affect normal force and friction. And one more: confusing normal force with weight – on an incline, N is less than W; in a vertical acceleration, N can differ from W as shown. You must use Newton's second law to find N in non-trivial cases, not just assume $N = mg$.

Equation Passport: Weight Formula – calculates the gravitational force (weight) on a mass near Earth's surface. This is used to find the **force of gravity** to include in $\sum F = ma$ equations.

Formal Equation: $W = m\,g$

Variables and Units:

- W – weight (gravitational force) of an object; units: newton (N) in SI, pound-force (lbf) in US customary
- m – mass of the object; units: kilogram (kg) in SI, or slug (slug) in US customary (sometimes given in pound-mass (lbm); if so, convert to slugs by dividing by 32.174)
- g – acceleration due to gravity; units: m/s² in SI, ft/s² in US. On Earth's surface, $g \approx 9.81$ m/s^2 ≈ 32.17 ft/s^2 (standard average value). The exam typically uses 9.81 or 9.8 m/s² if needed in calculations (or 32.2 ft/s² for US units).

Assumptions and Scope:

- Valid near Earth (or any planetary body with known gravity g). We assume g is constant over the region of motion (true for small height changes relative to Earth's radius).
- Applies to point-mass or rigid body where entire weight acts at a point (usually through the center of mass). This is fine for virtually all particle problems.
- This is a specific case of Newton's second law: it's basically $F_{\text{gravity}} = m \times g$. We assume no other significant gravitational influences (e.g., neglect moon or other planets – Earth's gravity dominates in typical scenarios).
- The weight force acts vertically downwards toward Earth's center. There's no "horizontal weight" component; any horizontal effect of gravity comes indirectly (like on an incline, weight has a component along the incline only because the incline plane is tilted relative to vertical).

Limit Tests:

- If $m = 0$, then $W = 0$. *Check:* zero mass means an object with no substance would have no weight – trivial but consistent.
- If $g = 0$ (imagine outer space far from gravity), then $W = 0$. *Check:* no gravitational field means even massive objects are weightless (though they still have mass/inertia). This distinction was historically important (astronauts are weightless in orbit but not massless).
- If m doubles, W doubles linearly (weight is directly proportional to mass). This linear relation is straightforward: heavier (in mass) means proportionally heavier in weight. If g changes (say on Mars $g \approx 3.71$ m/s^2), a given mass has less weight there: e.g. a 10 kg mass weighs 98.1 N on Earth, but only about 37.1 N on Mars.
- Also, consider extreme scenario: if you accidentally treated weight as ma for some other acceleration, result would likely be nonsense (e.g. plugging a of a car into $W = ma$ would not equal mg unless that acceleration equals g). So ensure $W = mg$ specifically uses g (the gravitational acceleration).

Use vs. Sibling Equations: Use $W = mg$ to **compute the force of gravity** whenever you need to plug gravity into $\sum F = ma$. This is instead of, say, using $F = ma$ with $a = g$ generically – which is essentially the same but $W = mg$ emphasizes it's specifically the weight force. Do not confuse this with other formulas: for instance, do **not** use $W = ma$ with an a that's not g; W has meaning only for gravitational acceleration. Also, use $W = mg$ rather than $F = ma/g_c$ in US units by converting mass to slugs first (less error-prone). Another related concept: **mass = weight/g**. If a problem gives a weight (force) and you need the mass, you can rearrange to $m = W/g$. For example, if something weighs 100 N, its mass is $100/9.81 \approx 10.2$ kg. Use this to avoid plugging weight where mass is needed.

Common Exam Traps:

- **Mixing up m and W in equations:** As stressed, do not plug weight (in N or lbf) in place of mass in $F = ma$. Always convert: if given weight = 50 N, and you need to use $F = ma$, first find $m = 50$ N$/9.81$ m/s$^2 \approx 5.10$ kg. Then use 5.10 kg as the mass. Conversely, if asked for weight given mass, multiply by g. A classic mistake: a problem says "A 5 kg object…" and someone writes 5 kg $\times$ 5 m/s^2 = 25 kg·m/s^2 and calls it newtons without multiplying by g at all, or uses g when not needed. Keep it straight: use g only for computing gravitational force, not for any acceleration.
- **Sign error with weight in $\sum F$:** If you set up $\sum F_y = ma_y$ and take upward positive, remember to include weight as $-mg$. It's easy under exam pressure to accidentally write $ma_y = mg$ for a free-fall (missing the negative sign), which gives a sign-flipped result. Another scenario: in an upward acceleration case (like the elevator), writing $N + mg = ma$ (assuming up positive) would be wrong – it should be $N - mg = ma$ (because weight acts downward). A good practice is explicitly write out $\sum F_y = N + (-mg) = ma_y$ to remind yourself how the signs come in.
- **Assuming $N = W$ always:** In many static cases, normal equals weight. But if there's vertical acceleration or additional vertical forces, normal will differ. The exam may test this by asking for apparent weight or normal force in an accelerating system. Don't just automatically set $N = mg$; use $\sum F$ in the vertical direction to solve for N.
- **Ignoring weight on an incline or slope:** Sometimes students will plug $F = ma$ along a slope and forget the component of gravity entirely, especially if a friction or applied force is present. Always ask: is gravity trying to pull this object in the direction we're considering? On an incline, yes – include $mg\sin\theta$. If you find yourself computing acceleration of a sliding object and not using g at all, double-check – likely something's off unless it's a horizontal surface or the problem explicitly says ignore gravity (which none will, really).

Exam Handbook Search Cues (Not affiliated with or endorsed by NCEES): "weight $W = mg$"; "gravity"; "weight vs mass"; "force of gravity"

Footnotes:

- *Standard g on exam:* Unless told otherwise, use $g = 9.81$ m/s^2 (or 32.2 ft/s^2) for calculations. Occasionally an exam problem might approximate g as 9.8 or even 10 m/s^2 for simplicity – if so,

they will make it clear in the problem statement ("use $g = 9.8$ m/s²"). Follow the problem's instruction. If none is given, stick to 9.81. The difference is minor in most cases but could shift a multiple-choice answer, so use what they expect.

- *Weight vs. mass units in US system:* 1 lbm (pound-mass) has a weight of 1 lbf (pound-force) under standard gravity. This can be confusing. In engineering, we often convert: a mass in lbm can be turned to slugs by dividing by 32.174, and then use $F = m_{\text{slug}}a$ directly. Alternatively, as mentioned, include g_c in formulas. For weight specifically, $W(\text{lbf}) = m(\text{lbm}) \times g(\text{ft/s}^2)/32.174$. If you mistakenly treat lbm as slugs, you'll get answers off by a factor of ~32.2. Keep an eye on units: the exam might give weight in lbf and ask for acceleration in ft/s²; in that case, first find mass in slugs, etc.

- *Apparent weight:* Sometimes the term "apparent weight" is used – this usually means the normal force felt by an object (like what a scale reads). As we saw in the elevator example, apparent weight = $N = m(g + a_y)$ when accelerating upward, or $m(g - a_y)$ when accelerating downward (taking upward positive). If the exam asks something like "What is the apparent weight of X during scenario Y?", they are nudging you to compute the normal force by including weight in the $\sum F = ma$ equation.

- *Other forces in handbook:* The reference handbook lists common formulas: friction $f = \mu N$, hooke's law $F_s = kx$, etc. Those are straightforward to include: just remember to plug them into $\sum F = ma$ as F terms. For example, if a spring is pulling a mass to the left, and you take right as positive, then in $\sum F_x$ you'd include $-kx$ for that spring force. It's all about careful bookkeeping of all forces.

Variations, Related Forms, Typical Values:

- **Mass from weight:** $m = \frac{W}{g}$. Use this to convert a given weight into mass for dynamics calculations. E.g., weight = 30 N $\Longrightarrow m = 30/9.81 \approx 3.06$ kg. Weight = 100 lbf $\Longrightarrow m = 100/32.17 \approx 3.11$ slugs. This is a direct rearrangement of $W = mg$. It's surprising how often you need this – anytime a problem gives weight but you need to compute acceleration or use $F = ma$, do this first.

- **Friction maximum:** $f_{\max} = \mu_s N$. Mentioned earlier, static friction can range from 0 up to $\mu_s N$. If your $\sum F = ma$ requires more friction than $\mu_s N$ can provide, the object will slip. Sometimes exam questions will ask for the acceleration *if* it slips vs. *if not*, etc. Including weight matters because N often equals or relates to weight (on flat ground $N = W$, on incline $N = mg\cos\theta$). So friction limits tie back to weight. For instance, on an incline, the condition for no slip is $mg\sin\theta \le \mu_s(mg\cos\theta)$ – the mg cancels, giving $\tan\theta \le \mu_s$. A typical value: if $\mu_s = 0.5$, then θ can be up to ~26.6° before slipping.

- **Drag and other forces:** If a problem involves drag (air resistance) or thrust, those forces will be given by some formula or value (drag often $F_D = \frac{1}{2}\rho C_d A v^2$ – though that's probably beyond FE detail except conceptually). In any case, treat them like any other force in $\sum F = ma$. They might ask conceptually: "at terminal velocity, weight equals drag" – which is a force balance $\sum F = 0$. Or "Given a thrust and weight, find acceleration of a rocket of certain mass (neglecting air)" – you'd do $T - W = ma$. Weight plays a big role in such rocket/airplane questions, obviously opposing upward motion.

- **Typical magnitudes:** Weights can range widely. If they give a mass in kg, multiply by ~10 to get weight in newtons (makes a quick estimation). A person ~70 kg has weight ~690 N. A small 5 kg object weighs ~49 N. Forces like tension or normal in everyday problems often end up on the order of hundreds or thousands of newtons as well (because they are often counteracting weight or providing acceleration to masses of tens to hundreds of kg). Keep an eye on the scale: if you get a normal force of 10,000 N for a 5 kg object, that's way off (should be ~50 N if just supporting it, or somewhat more if big acceleration). Use such clues to catch algebra slips.

- **Multiple objects (connected systems):** In dynamics, you might have two masses connected by a rope (like Atwood's machine: one goes up, one down). Incorporating weight correctly for each mass is vital. You'd write equations for each mass separately: for mass1 (going up?), $T - m_1 g = m_1 a$; for mass2 (going down?), $m_2 g - T = m_2 a$. Solving those simultaneously gives acceleration. The key is that each weight is treated as a force in each equation, with sign depending on assumed acceleration direction. Many students mix sign between the two equations – a hint is to define a single consistent positive direction for the system (say positive = direction of motion for mass1, and thus negative for mass2's motion if one goes up another down). Then weight terms follow consistently (one enters negatively, the other positively).

- **Normal force variations:** Typical trick: something in an accelerating elevator or in a rotating ride. E.g., a 50 kg person on a scale in an elevator decelerating downward at 3 m/s² (meaning acceleration is upward 3 m/s²): $\sum F_y$: $N - mg = ma$ so $N = m(g + a) = 50(9.81 + 3) = 50(12.81) = 640.5$ N. If instead accelerating downward (feeling lighter), $N = 50(9.81 - 3) = 340.5$ N. Or in a loop-de-loop, at the top $N + mg = mv^2/R$ (both gravity and normal act downward toward center, needing to provide centripetal force – if N comes out zero, that's the minimum speed for which the person just loses contact). These scenarios all involve including mg with correct sign in Newton's 2nd law equations.

Special Notes – Calculator: Including weight in calculations usually just means multiplying by 9.81. That's straightforward, but a couple of pointers: If you use a calculator in RPN mode (like the HP 35s), you might input weight calculations as m ENTER 9.81 * to get W. In algebraic calculators (Casio/TI), just do m * 9.81. The main issues are unit conversion: ensure m is in kg if you use 9.81 m/s², or if m is in slugs use 32.2 ft/s². If you have a weight and need mass, you'll do W / 9.81. Be mindful that some problems might give g with slight variation (like 9.8); adapt accordingly. Also, if you're dealing with several forces, organize your calculation to avoid sign mistakes: it can help to actually compute $W = m * 9.81$ first, then plug into the force sum. For instance, for an incline problem on the calculator: you might compute W = m*9.81, then Wx = W * sin(theta), N = W * cos(theta), then m*a = W*sin(theta) - friction. This stepwise approach reduces algebra errors. Another note: the TI-36X Pro and similar can solve equations directly; you could set up something like N - m*g = m*a and solve for N given a, but that's overkill – it's easier to just compute piecewise. The calculators have no trouble with $9.81 * mass$` etc. Just remember to include that g in the right spot – the calculator won't remind you if you forget it in a weight calculation! One last tip: store g in a memory if you're doing multiple gravity calcs (some calculators let you store constants). It saves a bit of time and ensures consistency.

Explanation & Analysis (Step-by-Step): Incorporating weight and other forces into $\sum F = ma$ is essentially about being thorough and careful. Let's illustrate with a **block on an incline with friction**, a quintessential example combining weight, normal, friction, and applied force:

Scenario: A 10 kg crate is on a 30° incline. Coefficient of kinetic friction $\mu_k = 0.2$. It's being pulled **up** the incline by a rope with tension $T = 50$ N. What is the acceleration of the crate (magnitude and direction)?

1. **Draw and list forces:** The crate (our particle) has the following forces: Weight $W = mg = 10 \times 9.81 = 98.1$ N acting vertically downward. A normal force N from the plane acting perpendicular *out of* the surface (the crate is pressed against the incline, so N points away from the surface, into the crate). A frictional force f opposing motion – since the rope pulls up the incline, the crate tends to move up, so friction will act **down** the incline (trying to resist upward sliding). And the rope tension $T = 50$ N pulling *up* along the incline. Draw the incline, draw the crate on it. Weight straight down. Normal perpendicular to surface (at 30° to vertical, pointing out). Tension up along the plane. Friction down along the plane. Label all with their values or symbols: $W = 98.1$ N, N (unknown), $T = 50$ N, f (unknown for now, but we know $\mu_k N$ will give it since crate presumably is moving if tension is applied; if it wasn't moving, static friction would apply up to a limit).

2. **Coordinate axes:** It's logical here to choose axes aligned with the plane: let's take x-axis along the incline (positive **up** the incline, since the pull is that way) and y-axis perpendicular to incline (positive **outward** from the surface). This way, acceleration will likely be along x (either up or down incline), and $a_y = 0$ because the crate won't jump off or dig into the plane – it stays on the surface so no acceleration perpendicular to it. Now we resolve weight into components: Weight W has a component perpendicular to plane $W_y = W\cos 30°$ (pointing into the plane, i.e. opposite to positive y) and a component parallel to plane $W_x = W\sin 30°$ (pointing down the plane, opposite to our positive x direction). Numerically, $\cos 30° \approx 0.866$, $\sin 30° = 0.5$. So $W_y = 98.1 \times 0.866 \approx 85.0$ N (into plane), $W_x = 98.1 \times 0.5 = 49.05$ N (down along plane). Check: those two components should vector-sum to the full weight (they do, by Pythagorean sum $85^2 + 49^2 \approx 98^2$).

3. **Write $\sum F$ equations:** Now apply $\sum F = ma$ on each axis.

4. **Perpendicular (y) axis:** $\sum F_y = ma_y$. The forces perpendicular to plane are: Normal N (positive y direction, out of plane) and the perpendicular component of weight $W_y = 85.0$ N (negative y direction, into plane). Friction and tension have no components perpendicular (they lie along plane). So $\sum F_y = N - W_y$. There is no acceleration out of plane (crate isn't lifting off or crushing into the plane), so $a_y = 0$. Thus: $N - 85.0\text{ N} = 10\text{ kg} \times 0$, meaning $N = 85.0$ N. We find the normal force: $N = 85.0$ N. (It's less than the full weight 98.1 N, as expected, because the incline supports only part of the weight – the rest is "used" in parallel component causing motion.)

5. **Parallel (x) axis:** $\sum F_x = ma_x$. Along the plane, taking up the incline as positive: we have tension $T = +50$ N (upward pull), friction f which is kinetic and acts downward so its force is $-f$ in the equation, and the parallel component of weight $W_x = 49.05$ N acting downward (i.e. -49.05 N in the sum). So: $\sum F_x = T - f - W_x$. This equals ma_x: $T - f - W_x = 10\text{ kg} \times a_x$. Now, we need f. Since the crate is being pulled and presumably moving (they didn't say "at rest" or "just about to move," so likely kinetic friction applies), $f = \mu_k N = 0.2 \times 85.0 = 17.0$ N. That friction always acts opposite motion (down plane here). Now plug in values: $50 - 17.0 - 49.05 = 10\,a_x$. So $50 - 66.05 = 10\,a_x$. That gives $-16.05 = 10a_x$. So $a_x = -1.605$ m/s^2. The negative sign indicates that the acceleration is actually **down the plane** (since we assumed up was positive, a negative result means the acceleration is 1.605 m/s² *downhill*).

6. **Interpret the result:** The magnitude of acceleration is 1.605 m/s^2. Direction: down the incline. What does this mean physically? We assumed the rope pulls up with 50 N, but gravity's component down (49 N) plus friction (17 N) together were 66 N opposing that pull. So the net force came out negative (downhill), meaning the crate actually slides downward – the pull wasn't strong enough to overcome gravity + friction. In other words, although we applied an upward force, it's too small; the crate still accelerates down. Many FE exam problems work out this way: you assume one direction, and the math tells you if you were right or not. It's fine – just report the acceleration as 1.61 m/s² down the incline (or say "downward along the plane"). We included weight properly (it was central to the calculation, providing 49 N down-slope), included friction (17 N), and tension. Had we forgotten weight, we'd have wrongly gotten $a_x = (50 - 17)/10 = +3.3$ m/s^2 up the plane, which is opposite of truth. Or if we forgot friction, $a_x = (50 - 49)/10 = +0.1$ m/s^2 up – also wrong (and unrealistic, given friction is present). Including all forces correctly gave a consistent answer.

7. **Check extremes:** If the incline were frictionless (μ=0), we'd have $50 - 0 - 49.05 = 10a_x$, so $a_x = +0.095$ m/s^2 up – the crate would barely accelerate up (the rope just slightly wins over gravity). If tension were higher, say 100 N, then $100 - 17 - 49 = 34\text{ N} = 10a_x$, $a_x = +3.4$ m/s^2 up – strong upward acceleration. If tension were zero (just a block on incline with friction), $\sum F_x = -f - W_x$. Static friction could hold it if μ_s was enough, but with kinetic 0.2, it would slide down slowly since $f_k(17N) < W_x(49N)$, giving net $-32N$ down: $a = 3.2$ m/s^2 down. All these make sense. The one we computed is in between those scenarios.

8. **General lessons:** Incorporating weight and other forces means carefully handling each force in the $\sum F = ma$ equation. Weight is often the easiest to identify (just mg downward), but you must project it into your axis system as needed. Normal forces are usually found via the perpendicular force balance (especially with no acceleration off the surface). Friction comes from $f = \mu N$ if sliding or inequality if static (the exam might directly give the friction force or the coefficient; be ready to use both). Tension or applied forces are typically given. The second law then becomes a matter of plugging these into $\sum F = ma$ with correct signs.

   Finally, always double-check units: in our example, everything was SI (N, kg, m/s²), which is consistent. If it were in US units, we'd have perhaps weight given in lb, mass we'd convert to slug, friction via μN in lb, etc. And check the direction your result indicates – if the sign is negative, articulate what that means (object accelerates opposite to assumed positive). On the FE exam, as long as you set up clearly, even if you assume wrong direction, your equations yield a negative acceleration which you can then interpret correctly in words or as a vector direction. The graders (or computer) will consider magnitude and perhaps direction in multiple-choice. So you might choose an answer "1.6 m/s² down the incline" from options.

This subtopic's takeaway: **Never ignore weight when it's relevant, and systematically include all forces**. Weight mg is often the starting force you write down for any object near Earth. Then add normals, frictions, tensions, etc., as applicable. Each force has a proper place in $\sum F = ma$. Mastering this means you can confidently handle any dynamics problem: you won't be thrown off by an extra force here or there, because your method (FBD → $\sum F = ma$) naturally accounts for them. It's a bit like bookkeeping – no term left unaccounted. Do that, and Newton's second law will carry you through even complex scenarios with ease.

Topic 04 - Work–Energy

Topic Introduction – Work–Energy: This chapter covers the **Work–Energy** methods in dynamics, an essential toolset for the FE Mechanical Exam. Work–energy principles provide an alternative way to solve kinetics problems by focusing on energy transfers instead of forces and accelerations over time. This is especially powerful for exam problems where you need to find speeds, heights, or distances without dealing with the time or complex motion directly. By accounting for how work done by forces converts into kinetic and potential energy, you can often sidestep lengthy kinematics and go straight to the answer. Typical FE questions that use work–energy involve objects moving under forces (gravity, springs, applied forces, friction, etc.), where you're asked to find an object's velocity after moving a certain distance, the height it reaches, or the work or power associated with a machine. In all cases, mastering work–energy will help you **save time on exam day** by turning force and motion problems into straightforward energy accounting. Let's dive into the subtopics that make up Work–Energy for the FE Mechanical exam.

K07.T04.S01 – Work–Energy Principle for Particles (Work Done = Change in Kinetic Energy)

Principle Introduction (Intuition & Setup): According to the work–energy principle, the change in a particle's kinetic energy is numerically equal to the net work done on the particle. In simpler terms, when forces do work on an object, they either increase or decrease its energy of motion. Key points to build intuition include:

- **Energy from Work:** Pushing or pulling an object (doing work on it) changes how fast it moves. Positive work (force in direction of motion) gives the object kinetic energy (speed), while negative work (force against motion, like friction or braking) takes kinetic energy away.
- **Scalar Equation:** Work and energy are **scalars** (no direction), so we can sum work from all forces and equate it to a single number for energy change. This makes calculations easier than vector force analysis in many cases.
- **No Time Variable:** Unlike $F = ma$ and kinematics equations, the work–energy principle doesn't require time or acceleration explicitly. It connects forces *over a distance* directly to velocity change, which is often a simpler route on exam problems where time is not given.
- **General Applicability:** This principle applies to **any particle** (treating an object as a point mass) regardless of the path taken. All that matters is the total work done and the initial and final speeds.
- **Include All Forces:** *Net* work means you must account for work done by **every force** acting on the object (applied pushes/pulls, weight, normal forces, friction, spring forces, etc.). However, not all forces do work – for example, a normal force perpendicular to motion does no work. Identifying which forces do work (and their signs) is crucial.

Exam Handbook Search Cues (Not affiliated with or endorsed by NCEES): *"work energy", "work–energy principle", "net work", "kinetic energy change"*

Equation Passport – Work–Energy Principle (Particles) – relates the sum of work done on a particle to its change in kinetic energy. This is the core equation for solving work–energy problems for a single mass moving without rotation:

Formal Statement: *The net work done by all forces on a particle equals the change in the particle's kinetic energy.* In equation form: $W_{\text{net}} = \Delta K = K_2 - K_1$ *Here* 1 *and* 2 *denote the initial and final states of the particle.* Another common rearrangement is: $K_1 + W_{\text{net}} = K_2$ which says the particle's initial kinetic energy plus the work done on it yields its final kinetic energy.

Variables and Units:

- W_{net}: **Net work** done on the particle as it moves from state 1 to 2 (SI unit: joule, J). "Net" means sum of work by **all forces**. Positive W_{net} increases kinetic energy, negative W_{net} (e.g. from friction or opposing forces) decreases kinetic energy.
- K_1, K_2: **Kinetic energy** of the particle at the initial state 1 and final state 2, respectively (unit: J). $K = \frac{1}{2}mv^2$ for a particle (defined formally in the next subtopic).
- ΔK: Change in kinetic energy $K_2 - K_1$ (J). This will be positive if the particle speeds up, negative if it slows down.

Assumptions and Scope:

- *Particle (translational motion only):* This form assumes the object can be treated as a particle (no significant rotation). For an extended rigid body that rotates, you must include rotational kinetic energy and work from torques (see **Variations**).
- *Consistent reference frame:* Kinetic energy is calculated in a given reference frame. Work must be computed using forces and displacements measured in that same frame.
- *Work accountancy:* All forces doing work are included. If a force does no displacement (e.g. static support) or is perpendicular to motion (no component along displacement), it does no work and is excluded.
- *No other energy forms:* This principle accounts only for mechanical work and kinetic energy. It assumes no energy is lost to heat or added via other forms like electricity, unless those are modeled as "forces doing work" in the system.

Limit Tests (Sanity Checks):

- **No Work, No Change:** If $W_{\text{net}} = 0$ (either no forces act, or forces balance such that no net work is done, or the displacement is zero), then $\Delta K = 0$. The kinetic energy stays the same – consistent with an object moving at constant speed or remaining at rest.
- **Energy Additivity:** If you push twice as hard over the same distance, you do double the work, yielding double the kinetic energy gain (linear in work). If the particle's speed doubles, check that the required work is $W_{\text{net}} =$

$\frac{1}{2}m(v_2^2 - v_1^2)$ – it should match expectations (four times the kinetic energy if speed doubles, since $K \propto v^2$).

- **Zero Initial Speed:** If the object starts from rest ($K_1 = 0$), then $W_{\text{net}} = K_2$. That means all the work done goes into generating kinetic energy. If you get a negative K_2 from calculations, something's wrong – kinetic energy cannot be negative (check your work signs).

- **Use vs. Sibling Equations:** Use **Work–Energy** instead of Newton's second law ($F = ma$) and kinematics when you don't need the time history and only care about the start and end states. For example, **use this equation when** you have forces and distances and want velocity, or vice versa. **Do not use** a pure energy approach when dealing with collisions or impulse problems – in those cases, impulse–momentum might be more appropriate (unless energy conservation applies). Compared to the impulse–momentum method (which relates force & time to velocity), work–energy relates force & distance to velocity. Also, if rotation is involved, use the extended work–energy form that includes rotational kinetic energy (rather than trying to apply simple particle work–energy).

Common Exam Traps:

- *Forgetting a force:* Students sometimes omit a force that does work (e.g. forgetting the work done by gravity or a spring). Always list **all forces** on the object and determine which do work as it moves. If you leave one out, your W_{net} will be incomplete.
- *Sign errors:* Be very careful with the **sign of work**. Work done *by* a force is positive if the force has a component in the direction of motion, but **negative** if the force opposes the motion. For example, if a box slides up a ramp, gravity does negative work (it's pulling down opposite to motion), and friction (if present) also does negative work. In computing W_{net}, you'd add a negative term for those forces. A quick check: if the object slows down, ΔK is negative, so W_{net} should come out negative.
- *Unit mistakes:* Work and energy in SI units are in joules (N·m). In US Customary units, work/energy might be in foot-pounds (ft·lbf). **Do not mix up force and energy units.** For instance, 1 lbf (a unit of force) is not 1 ft·lbf (unit of work). Also, if mass is given in slugs or pound-mass, use consistent units to get work in ft·lbf. *(See Footnotes for unit conversion nuances.)*
- *Confusing work with energy storage:* Remember, work is something **done** *to* or *by* the object, while kinetic energy is something the object **has**. The equation $W_{\text{net}} = \Delta K$ is basically bookkeeping: it transfers energy from forces *into* the object's kinetic energy or out of it. If you get a sign reversed (like setting $W_{\text{net}} = K_1 - K_2$ by mistake), you'll effectively violate energy conservation and get non-physical results.

Footnotes:

- *Work Calculation:* To compute W_{net}, you can sum up work from each force: $W_{\text{net}} = W_1 + W_2 + \cdots$. For a constant force F making angle θ with displacement s, the work is $W = F\,s\cos\theta$. For a variable force, $W = \int \mathbf{F} \cdot d\mathbf{r}$ (integral of force along the path). The exam usually provides manageable scenarios (constant forces, spring forces, weights over vertical distance, etc.), so you often won't need to perform tough integrals – just apply the appropriate formula for each contribution.

- *Signs and Datum:* It can help to define a positive direction for displacement. Work done by a force is positive if the displacement component is in the force's direction. If you define upward as positive for displacement, then gravity (weight $W = mg$ acting downward) doing work will come with a negative sign when the object moves upward ($\cos 180° = -1$ in $W = Fs\cos\theta$). Alternatively, many prefer to include gravity via potential energy (next subtopics) to avoid sign confusion.

- *Energy Units in USCS:* In US Customary units, be mindful of the g_c factor for kinetic energy and potential energy if you use pound-mass (lbm) and pound-force (lbf). Using the formula $K = \frac{1}{2}mv^2$ with m in lbm and v in ft/s will yield energy in units of lbm·(ft/s)^2, which is not directly ft·lbf. To convert to force–length units, include $g_c = 32.174\ \frac{\text{lbm·ft}}{\text{lbf·s}^2}$ in the denominator: $K = \frac{1}{2}\frac{mv^2}{g_c}$, and similarly $PE = \frac{mgh}{g_c}$, to get energy in ft·lbf. Alternatively, convert masses to slugs (1 slug = 1 lbm/g_c) and use $g = 32.174$ ft/s^2 directly. The FE Exam handbook provides these forms to ensure consistent units. Always check units if mixing unit systems to avoid errors by factors of g_c.

Variations and Related Forms: - *Including Potential Energy (Conservative Forces):* The pure work–energy principle can be rearranged to include potential energy changes for forces like gravity or springs. If you move those terms to the other side, you get the **mechanical energy conservation form**: $K_1 + PE_1 + W_{\text{nc}} = K_2 + PE_2$. In other words, instead of directly computing work by gravity or a spring, you can treat those as stored energy changes (this is exactly what we'll formalize in subtopic S03). Use whichever approach (work of forces vs. potential energy) feels more straightforward for the problem at hand – they are equivalent if done correctly. - *Work–Energy with Rotation:* For rigid bodies that rotate or roll, the work–energy principle extends by including **rotational kinetic energy** and work done by moments/torques. The generalized form is $W_{\text{net}} = \Delta K_{\text{trans}} + \Delta K_{\text{rot}}$. For example, a wheel rolling without slipping might have both $\frac{1}{2}mv^2$ and $\frac{1}{2}I\omega^2$ terms for kinetic energy. Also, a torque M through an angle θ does work $W = M\,\theta$. These extensions are usually needed for problems involving rotating machinery or rolling objects on the FE exam. *(If the FE Mechanical exam specification lists "work-energy of rigid bodies," be prepared to add rotational terms accordingly.)* - *Work vs. Heat:* Remember, work and heat are two distinct ways to transfer energy. The work–energy principle deals only with work. If a problem involves friction where mechanical energy is "lost," that lost energy typically turns into heat. In work–energy terms, friction's work is negative and reduces mechanical energy. The first law of thermodynamics (in thermodynamics topics) would account for that lost energy as heat, but in dynamics problems we usually just note it as energy not available for kinetic/potential anymore. - *Converting Work to Potential Energy:* Work done **against** a conservative force (like lifting an object against gravity or compressing a spring) increases the object's potential energy. In the work–energy equation, you'd have a negative work term (since those forces oppose motion), but you can think of it as that work being stored as potential energy. This is why moving those terms to the other side yields $+\Delta PE$.

Explanation & Analysis (Step-by-Step Use): To apply the work–energy principle in a typical problem, follow these steps:

1. **Identify Initial and Final States:** Clearly define the two points (state 1 and state 2) you're considering – e.g. the start and end of a motion of interest. You will compare energies between these states.

2. **List All Forces and Work Terms:** Draw a quick free-body diagram if needed. Determine which forces do work as the particle moves from state 1 to 2. For each force, figure out the work done:

- Applied force (engine, push, tow, etc.): $W = F\,d\cos\theta$.

- Gravity: $W_{\text{grav}} = mg\,\Delta y$ (with sign: if Δy is downward, gravity's work is positive since it adds kinetic energy; if upward, work is negative).

- Springs: $W_{\text{spring}} = -½k(x_2^2 - x_1^2)$, the spring does negative work on the object if it's being compressed (object losing energy to spring) or positive if extending (spring giving energy). - Friction: $W_{\text{friction}} = -f_k\,d$ (always opposes motion, so always removes energy – negative work).

- Normal forces: usually $W_{\text{normal}} = 0$ if the motion is along the surface (no displacement perpendicular to surface).

3. **Compute W_{net}:** Add up all those work contributions (be careful with signs!). This sum is your W_{net}.

4. **Compute Kinetic Energy Change:** Determine the particle's initial kinetic energy $K_1 = ½mv_1^2$ and final kinetic energy $K_2 = ½mv_2^2$. Then $\Delta K = K_2 - K_1$.

5. **Set $W_{\text{net}} = \Delta K$:** Plug in your values. This equation will allow you to solve for the unknown of interest – often the final speed v_2, or a required force F, or a distance d needed for a certain energy change, etc.

6. **Solve and Double-Check:** Solve the equation for the target variable. Check that the result makes sense physically (e.g., more work yields higher speed; negative work yields a slower or zero speed; if friction is present, final kinetic energy is less than it would be without friction, etc.). Ensure units are consistent (convert to J or ft·lbf as needed).

7. **Quick Reality Check:** If the numbers are extreme (say you got a final speed of 1000 m/s for a small push), re-examine the work calculations or sign conventions – it's easy to make a sign error or unit mix-up in energy equations. Use the limit tests as guidelines: if friction was present, did your result show less kinetic energy than the no-friction scenario? It should.

In summary, the work–energy principle for particles is a straightforward but powerful tool: it's like balancing a checkbook for energy. You start with some kinetic energy "balance," add or subtract energy via work done, and end up with a new kinetic energy. Master it, and many seemingly tough dynamics problems become one-line calculations!

K07.T04.S02 – Kinetic Energy of a Particle and Gravitational Potential Energy

Principle Introduction (Intuition & Setup): Energy comes in different forms. For moving objects, the primary forms of mechanical energy are **kinetic energy** (energy of motion) and **potential energy** (stored energy of position or configuration). In this subtopic, we define the kinetic energy of a particle and the gravitational potential energy of an object in a gravity field. These are the building blocks for work–energy calculations:

- **Kinetic Energy (KE):** This is the energy a particle has by virtue of its velocity. If an object is moving, it can do work (think of a hammer hitting a nail – its motion energy drives the nail in). Kinetic energy increases with both mass and the square of speed; doubling the speed *quadruples* the kinetic energy. Intuitively, a fast-moving object carries a lot more energy than a slow one of the same mass.
- **Gravitational Potential Energy (PE):** This is energy stored in an object's position in a gravitational field – essentially, energy that can be released by letting the object fall. The higher an object is lifted against gravity, the more potential energy it gains (because gravity will do more work on it if it falls back down). It's "potential" because it hasn't become kinetic yet, but it could. If you drop the object, that stored energy converts into kinetic energy as the object speeds up.
- **Reference Datum:** Potential energy is relative – you must choose a reference height where $PE = 0$. Commonly we set the lowest point of motion or the ground as zero height. Lifting an object *adds* positive potential energy (relative to that zero), while lowering it can make the potential energy negative (meaning it's below the reference level – it would require positive work input to bring it up to zero height).
- **Energy Units:** Both kinetic and potential energy are measured in the same unit (joules in SI, or foot-pounds in US units), since they are just different forms of energy. This means you can directly add or compare kinetic and potential energy values in computations (e.g. convert all to joules, then sum).
- **Conversions:** These energies convert into each other. As an object falls, its loss in gravitational potential energy becomes an increase in kinetic energy (if no losses). Conversely, when you toss an object upward, kinetic energy is converted into potential (it slows down while gaining height). This interplay is the heart of many work–energy problems.

Exam Handbook Search Cues (Not affiliated with or endorsed by NCEES): *"kinetic energy", "½ m v²", "potential energy", "mgh"*

Equation Passport – Kinetic Energy of a Particle – calculates the energy of motion for a particle of mass m moving at speed v. This is the fundamental formula for translational kinetic energy:

Name and Purpose: Kinetic Energy (K) – computes the amount of energy a particle has due to its motion. It answers questions like "How much energy does this object have because it's moving at velocity v?" or "How much work could this object do on another if it stopped (by, say, hitting something)?"

Professional Equation: $K = \frac{1}{2}\,m\,v^2$

Variables and Units:

- K: **Kinetic Energy** (joules, J in SI; also N·m, which is equivalent to J. In US units, often foot-pound force, ft·lbf).
- m: **Mass** of the particle. Use kilograms (kg) in SI. In US customary, mass might be given in slugs; if given in pound-mass (lbm), convert to slugs or use the g_c correction (see Footnotes). Mass is a measure of inertia – heavier objects have more kinetic energy for the same speed.
- v: **Speed** of the particle (meters per second, m/s in SI; or ft/s in US units). This is the magnitude of velocity

(direction doesn't matter for kinetic energy, since energy is scalar and depends on v^2).

Assumptions and Scope:

- This formula assumes **classical mechanics** (speeds much lower than the speed of light, so no relativistic effects). At everyday speeds, it's perfectly accurate for exam purposes.
- It applies to a **point mass** or any object moving without rotation (if the object is rotating, its translational kinetic energy is given by this formula using the speed of its center of mass, but the object also has rotational kinetic energy – not covered by this single formula).
- The speed v is measured relative to an inertial frame (typically the ground or a lab frame in exam problems, unless otherwise specified).
- Kinetic energy is always **non-negative**. If you plug in $v = 0$, you get $K = 0$. If you somehow got a negative number from $½mv^2$, you've made an algebraic mistake – kinetic energy cannot be negative because m and v^2 are always positive or zero.

Limit Tests (Sanity Checks):

- **Zero Velocity:** If $v = 0$, then $K = 0$. An object at rest has no kinetic energy – it won't do any work on another object or change its state unless acted upon.
- **Doubling Mass:** If you double the mass m while keeping v the same, kinetic energy doubles. (E.g., a 2-kg object at 10 m/s has twice the kinetic energy of a 1-kg object at 10 m/s.)
- **Doubling Speed:** If you double the speed v (with the same mass), kinetic energy goes up by a factor of 4 (since v^2 term). This quadratic sensitivity to velocity means speed changes affect kinetic energy dramatically – a common conceptual pitfall is underestimating how much energy high speeds carry.

Units Consistency: 1 J is 1 kg·m²/s². Plugging numbers into $½mv^2$ yields kg*(m²/s²) which indeed gives joules. In US units, if m is in slugs and v in ft/s, the result is ft·lb_f (which is the unit of energy). Always confirm that your units multiply out to an energy unit.

Use vs. Sibling Equations: This is the standard formula for **translational kinetic energy**. Use it whenever you need to quantify an object's energy of motion in a straight-line or general translation. **Do not confuse** this with **rotational kinetic energy** of a body spinning about an axis – that has a sibling formula $K_{rot} = \frac{1}{2}I\omega^2$ (where I is moment of inertia and ω is angular speed). If an exam problem involves rotation, you might need to use both formulas and add them (total kinetic energy = translational + rotational). Also, distinguish kinetic energy from **momentum** ($p = mv$); some students mix them up. Momentum is a vector and relates to impulse, whereas kinetic energy is scalar and relates to work – they are different concepts (though both increase with m and v).

Common Exam Traps:

- *Unit Confusion in USCS:* If a problem gives mass in pounds (which is ambiguous without context), remember that in engineering contexts **weight (force)** is often given in lbf while **mass** might be given in slugs or lbm. If you mistakenly treat 10 lb (which is likely a force/weight) as mass m in $½mv^2$ with v in ft/s, you'll get the wrong energy by a factor of 32.2. Convert that weight to mass in slugs (by dividing by $g \approx 32.2$ ft/s^2) or use the g_c factor method. Always clarify units for mass vs force.
- *Forgetting to Square the Velocity:* It's surprisingly common to see students forget the square or mishandle it when solving for v. For example, if $K = 100$ J and $m = 2$ kg, then $100 = ½(2)v^2$ leads to $v^2 = 100$, so $v = 10$ m/s (not 50 m/s or any other mis-step). Keep algebra clear: solve for v^2 then take the square root (and remember to consider units inside the root).
- *Not Halving Mass* (in rearrangements): When solving $½mv^2$ for one of the variables, be careful with the ½. For instance, solving for m gives $m = 2K/v^2$. It's a simple algebra step but easy to invert something by mistake under exam pressure.
- *Negative Heights Misinterpreted:* (Relates to potential energy but worth noting together.) If using energy methods with a chosen datum, kinetic energy formula always yields a positive value or zero. If you get a negative number inside a square root when solving for v using energy (e.g., $v^2 = 2gh$ and you accidentally put a negative height difference without a proper sign convention), it flags a setup error. Kinetic energy being negative or v^2 negative is non-physical – go back and fix sign usage in energy equations.

Equation Passport – Gravitational Potential Energy – computes the stored energy of a mass m at a height h in a gravitational field. This is the key formula for potential energy due to gravity near Earth's surface (constant g):

Name and Purpose: Gravitational Potential Energy (PE_g or U_g) – calculates how much energy is stored in an object of mass m due to its vertical position h above some reference level. It tells you how much kinetic energy *could* be obtained (or work could be done) if the object were allowed to fall from height h to the reference level.

Professional Equation: $PE_g = m\,g\,h$

Variables and Units:

- PE_g (also often denoted U or V): **Potential energy (gravitational)** (joules, J). It represents energy *possessed by* the object due to its height.
- m: **Mass** of the object (kg in SI; slugs in USCS if using g in ft/s²). This is the same m as in kinetic energy – the object's inertia. More mass means more weight, hence more energy needed to lift it a given height.
- g: **Acceleration due to gravity** (approximately 9.81 m/s^2 downward in SI; 32.2 ft/s^2 in US units). Use g as positive 9.81 in the formula if you treat h as the height *increase* measured upward. Essentially, mg is the weight (force) of the object.
- h: **Height** of the object above the reference datum (meters, m in SI; feet, ft in US). This is the vertical displacement from your chosen zero level. It can be positive (above datum), zero (at datum), or negative (below datum, meaning the object is below your zero height reference).

Assumptions and Scope:

- This formula assumes a **uniform gravitational field** (constant g), which is valid near the Earth's surface for modest height changes (basically any typical engineering scenario – height differences of meters or even hundreds of meters won't noticeably change g).
- The choice of reference **datum for** $h = 0$ is arbitrary – you set it for convenience. Only differences in potential energy matter physically. The work done by gravity when an object moves from height h_1 to h_2 is $mg(h_1 - h_2)$, which corresponds to the drop in PE_g. So you can set $PE = 0$ at the lowest point to keep all PE values non-negative, or at ground level, etc. The math will work out as long as you stick to one reference per problem.
- The object is treated as a particle (its entire weight acts at one point). For an extended object near Earth, you usually use the height of its center of mass in this formula.
- PE_g can be converted to kinetic energy fully if the object is dropped (neglecting air resistance). It's essentially the "fuel" gravity provides to speed something up during a fall.

Limit Tests (Sanity Checks):

- **Zero Height:** If $h = 0$ (at the reference level), $PE_g = 0$. Makes sense – at the reference height we define the zero of potential energy. If the object is on that level, it has no gravitational energy relative to that level.
- **Higher = More Energy:** If you double the height h, the potential energy doubles. Lifting 10 kg by 2 m (with $g \approx 9.81$) stores about 196.2 J; lifting the same mass by 4 m stores ~392.4 J (twice as much).
- **Mass & Weight:** If you increase the mass, potential energy increases proportionally. A 20-kg object at 10 m has twice the PE_g of a 10-kg object at 10 m. This is consistent because gravity would do twice the work in bringing the heavier object down the same distance (since it's twice the weight).
- **Negative Height:** If an object is below the reference (say $h = -5$ m relative to your datum), plugging that in gives $PE_g = mg(-5) = -mg \cdot 5$. A negative potential energy just means the object is "in the hole" relative to your reference. To raise it to zero height, positive work must be done (adding energy to the system). In calculations, the change in potential ΔPE is what matters: climbing out of a negative PE to zero means $+\Delta PE$.

Units Check: For SI, kg·m/s² (which is N) times m gives N·m, i.e. J. For US, if you use slugs for m and ft/s² for g, you get slug·ft/s² which is lbf, times ft gives ft·lbf – good. If you inadvertently used lbm for m and 32.2 ft/s² for g without adjusting, you'd get lbm·ft/s² which is not directly ft·lbf, highlighting the importance of g_c (see unit footnote above).

Use vs. Sibling Equations: This is the standard formula for gravitational potential energy in a uniform field (near Earth). It's to be used whenever you need to account for energy changes due to changes in height. **Do not confuse** this with **elastic potential energy** (for springs), which has the form $PE_{\text{spring}} = ½kx^2$ (we'll mention spring energy soon). Also, distinguish it from electric potential energy or others – in mechanical systems, gravity and springs are the main conservative forces providing potential energy.

Use $PE_g = mgh$ instead of directly integrating weight's work (which would give the same result but with a sign to consider). It's often easier to use mgh rather than summing work from gravity, as long as you consistently treat upward movement as adding potential (and downward as releasing it).

Common Exam Traps:

- *Misidentifying h:* Ensure h is the vertical height difference, not the distance along a slope or anything else. Only vertical rise/fall counts for gravitational energy. In a ramp problem, for instance, if a block slides down a 10 m long incline that drops 2 m vertically, $h = 2$ m (not 10).
- *Wrong Datum:* Choosing a reference and then forgetting to use it consistently can lead to sign mistakes. For example, if you set the bottom of a drop as $PE = 0$ and the top is $h = +5$ m, then an object at the top has $PE = +mg(5)$. After it falls to the bottom ($h = 0$), $PE = 0$. The change $\Delta PE = PE_{\text{bottom}} - PE_{\text{top}} = 0 - mg5 = -mg5$, meaning it lost that much potential (which turned into kinetic). If you inadvertently swap the sign or reference, you might add when you should subtract. A good practice is to write $\Delta PE = mg\Delta h$ and carefully note if Δh is negative (going down, negative change in height gives negative change in PE).
- *Forgetting Conversion in US units:* If using mgh in US customary units, remember m must be in slugs if $g = 32.2$ ft/s^2. A common error is to plug m in lbm as if it were slugs. Alternatively, you might use weight $W = mg$ directly: then W in lbf times h in ft gives ft·lbf (which is fine, actually a simpler way – just ensure W is the weight force).
- *Using the wrong g or mixing units:* On Earth, g is ~9.81 m/s² or 32.2 ft/s². The exam may provide a slightly rounded g (sometimes 9.8 m/s² or even 10 m/s² for simplicity in certain problems). Use the value given or standard, and importantly, don't mix 9.81 with feet or 32.2 with meters. That will yield nonsense. If a problem statement provides a specific g (e.g. "assume $g = 9.80$ m/s^2"), use it.
- *Treating PE as absolute:* The number you get for potential energy depends on your reference. If your friend chooses a different zero height, they'll get different absolute PE values, but any **physical answer (like final speed)** will agree because what matters is the change in PE. So, don't panic if you set up a conservation of energy equation and one person's equation has all terms plus a constant – that constant cancels out. It's changes that count. Just be self-consistent and focus on ΔPE in calculations.

Footnotes:

- *Notation:* In the FE Reference Handbook, gravitational potential energy might be denoted by V_g or just included as part of V (potential energy total). We're using PE or U interchangeably for potential energy here for clarity, and K for kinetic (some texts use T for kinetic energy).

- *Gravity as a Conservative Force:* The term "conservative" means gravity's work depends only on vertical displacement, not the path. Lifting an object straight up 5 m or pushing it up a long ramp that rises 5 m requires the same work (ignoring friction), and thus gives the same ΔPE_g. This is why we can define a potential energy function for gravity at all.

- *Small g Variations:* If a problem took place on another planet or at a great height, g might differ. The formula still applies with that g. On Earth, any variation of g with height in everyday problems is negligible for the exam; assume g constant unless explicitly told otherwise.

Variations and Related Forms:

- *Elastic (Spring) Potential Energy:* Another common form of potential energy in mechanical systems is for springs. A spring with constant k compressed or stretched by amount x stores energy $PE_{\text{spring}} = \frac{1}{2}kx^2$. Like gravity, spring force is conservative – if you compress a spring and let go, that energy converts to kinetic. While the subtopic outline didn't list it explicitly, remember to include spring energy in problems with springs. If both gravity and springs are present, you can have both mgh and $½kx^2$ terms in total potential energy.

- *Gravitational Potential beyond Earth's Surface:* If an exam problem were to use energy for large-scale gravity (unlikely in FE Mechanical), the more general formula is $PE = -\frac{GMm}{r}$ (where a negative sign indicates zero potential at infinity). But for near-Earth mechanical problems, stick to mgh.

- *Kinetic Energy in Rotational Form:* As noted, a rotation analog exists: $K_{\text{rot}} = \frac{1}{2}I\omega^2$. If an object is both translating and rotating (like a rolling wheel), the total kinetic energy is the sum $K_{\text{total}} = \frac{1}{2}mv^2 + \frac{1}{2}I\omega^2$. For a solid disk rolling without slipping, one can even relate ω to v by $v = \omega r$ (where r is radius) to express everything in terms of v. Be aware of this if a problem hints at rotational motion – you might need to use both forms.

- *Work–Energy Including Potential:* The definitions of K and PE_g feed directly into the conservation of energy (next subtopic). The idea is that K and PE can trade off. Work by non-conservative forces will change the sum $K + PE$, but if only conservative forces act, $K + PE$ stays constant. Always be ready to combine these definitions for solving problems (e.g., $½mv_1^2 + mgh_1 = ½mv_2^2 + mgh_2$ for a falling object with no losses).

- *Power from Kinetic/Potential Changes:* While K and PE tell you "how much" energy, sometimes you care about "how fast" energy changes (power). For instance, lifting a mass m at velocity v requires power $P = Fv = mgv$ (because you are increasing PE at that rate). Or a braking car dissipating kinetic energy K in time t is doing so at power K/t. This links kinetic/potential energies to the power concept (which we cover in S04).

Explanation & Analysis (Step-by-Step Understanding): Knowing these energy formulas allows you to compute and equate energies in problems:

- **Kinetic Energy in Use:** If a 1500 kg car is moving at 20 m/s (~72 km/h), its kinetic energy is $½(1500)(20^2) = 300{,}000$ J. This is the amount of energy it carries due to motion – roughly equivalent to the energy released by burning a few drops of gasoline. On the exam, you might use this to find how much work the brakes must do to stop the car (300 kJ of work, which would be $W_{\text{net}} = -300$ kJ to bring K to zero).

- **Gravitational PE in Use:** If that car is parked on top of a 50 m hill, it has $PE_g = mgh = 15009.8150 \approx 735{,}750$ J relative to the bottom. If it rolls downhill (frictionless), we can expect about 735 kJ of kinetic energy at the bottom if it started from rest (since PE lost converts to K). Indeed, equating $mgh = ½mv^2$ yields $v \approx \sqrt{2gh} \approx \sqrt{29.8150} \approx 31.3$ m/s (about 113 km/h). This shows the power of energy methods: quick way to find speed from height.

- **Sign Convention Recap:** In applying these, decide early: will I do this by conservation of energy ($K_1 + PE_1 = K_2 + PE_2$) or by work–energy ($K_1 + W_{\text{net}} = K_2$)? They're equivalent, but for clarity: if gravity is the only force, using mgh is easier than doing W_{grav}. If friction is present, you could still use mgh for gravity but then include W_{friction} as a separate work term (which will be negative). Practice a consistent method:

- Using **potential energy method**: Put all conservative energies (PE) on one side, and non-conservative work on the other. For instance, $K_1 + PE_1 + W_{\text{nc}} = K_2 + PE_2$. If friction is the only non-conservative force, $W_{\text{nc}} = -f_k d$. - Using **work directly**: Compute gravity's work as $+mg(h_1 - h_2)$ (which will be positive if dropping, negative if going up) and friction's work as $-f_k d$, etc., sum them and set equal to ΔK. Both ways should give the same K_2.

- **Energy Bar Charts:** Mentally (or even on scratch paper if time permits), it sometimes helps to draw an energy bar chart – initial K bar, initial PE bar, work added or removed, and final K and PE bars. This visual bookkeeping ensures you aren't creating or destroying energy unjustifiably. For example, if a problem says "a 2-kg block slides down a frictionless 3 m ramp and hits a spring", you'd start with PE_g (because of height), convert to K at bottom, then into spring PE. Drawing that out can clarify what equals what at different points.

- **Units and Magnitudes:** Keep an eye on magnitudes. Kinetic energies on the exam might range from tiny (a small object moving slowly, a few joules) to large (a vehicle or heavy object at speed, maybe 10^5 to 10^6 J). Gravitational PE typically involves heights of a few meters to maybe tens of meters in machine or structural contexts – usually not more than that in FE problems. If you get an energy value that seems off by orders of magnitude, re-check if you dropped a squared term or used the wrong mass unit.

- **Combining K and PE:** Many exam problems will involve a mix – e.g., a roller coaster at height with some initial speed: it has both K and PE. You'll then use energy conservation (if no losses) or work–energy (if there are losses/inputs) to find one of them later. Always compute initial K and PE separately, sum them for total mechanical energy at state 1, and do the same for state 2. Equate (with adjustments for any work done by non-conservative forces).

- **Energy is Reference-Independent:** If you accidentally set a weird zero for PE, as long as you include all forms consistently, the difference will cancel. For example, say at state 1 you get $K_1 + PE_1 = X$ (some number), and at state 2 you get $K_2 + PE_2 = Y$. If only conservative forces acted, energy conservation says $X = Y$. If both PE_1 and PE_2 had an extra +1000 J (because you chose a zero 100 m below ground, for instance), then X and Y would each be 1000 J bigger than otherwise, but the equation $X = Y$ still holds. Just be sure not to mix datum choices mid-problem.

- **Connecting back to Work–Energy:** The reason we introduce K and PE formulas separately is not just to plug into conservation equations, but also to use them in the work–energy principle from S01. For example, if you use the work–energy principle including gravity's work, you'll need K to evaluate ΔK, and you'll need to compute gravity's work which is $mg(h_1 - h_2)$ – effectively $-\Delta PE_g$. Recognizing that form will help you avoid mistakes. Likewise, knowing $K = ½mv^2$ is crucial for interpreting what a given kinetic energy means for speed (solving for v), which is often the end goal.

By firmly understanding kinetic and potential energy formulas, you lay the groundwork for solving any energy-related problem on the FE exam. They're simple equations, but incredibly powerful in application.

K07.T04.S03 – Conservation of Energy in Conservative Systems (Mechanical Energy Conservation)

Principle Introduction (Intuition & Setup): Conservation of mechanical energy is a special case of the work–energy principle that applies when **no non-conservative forces** (like friction, air resistance, or engine inputs) are doing work on the system. In such cases, the total mechanical energy (kinetic + potential) of an isolated system remains **constant**. This idea simplifies many problems: instead of dealing with work explicitly, you can just set total energy at one state equal to total energy at another. Key points include:

- **Mechanical Energy** = $K + PE$**:** The sum of kinetic and potential energies is often called *mechanical energy*. If only conservative forces (gravity, springs, etc.) are acting, mechanical energy doesn't change with time – it's conserved. The object can trade K for PE or vice versa, but the sum stays the same.
- **"No Losses" Scenario:** Energy conservation holds when there are no energy losses (to heat, sound, etc.) and no energy added by external non-conservative work. In practical terms, that means **no friction**, no drag, no inelastic deformation, no motor doing work on the system, etc. Of course, real life always has some losses, but many exam problems either assume ideal conditions or ask you to *neglect friction* to use energy conservation.
- **Two-State Relation:** If energy is conserved, you can relate two states directly: whatever energy you start with, you end with – just redistributed between K and PE. For example, an object sliding down a frictionless hill: at top it has $(K + PE)$top*; at bottom* $(K + PE)$bottom; set them equal to find unknown velocity or height.
- **Shortcut but Watch Conditions:** Conservation of energy is essentially a shortcut of the work–energy principle when $W_{\text{net}} = 0$ (no non-conservative work). Many students prefer this because it's conceptually straightforward and fewer terms to deal with. However, **be cautious**: if even a small non-conservative force is present (like a bit of friction), pure conservation of energy is no longer strictly true – you'd need to account for the work done (loss) by friction.
- **Conservative Forces and Potential Energy:** One reason to use energy conservation is if you have multiple conservative forces (say gravity and spring) acting – instead of calculating work by each, you can just use potential energies. It's often less error-prone to add up $K + PE$ at points than to integrate forces.

Exam Handbook Search Cues (Not affiliated with or endorsed by NCEES): *"conservation of energy", "mechanical energy", "T1 + V1 = T2 + V2", "conservative forces"*

Equation Passport – Mechanical Energy Conservation – **equates total mechanical energy at two states when no non-conservative work is done.** This is a direct consequence of work–energy with $W_{\text{net}} = 0$ (i.e., only conservative forces present):

Formal Equation: $K_1 + PE_1 \;=\; K_2 + PE_2$ This can be read as: *the sum of initial kinetic and potential energy equals the sum of final kinetic and potential energy.* It's often rearranged or expanded depending on the types of energy involved (gravity, springs, etc.), for instance: $\frac{1}{2}mv_1^2 + mgh_1 + \frac{1}{2}kx_1^2 \;=\; \frac{1}{2}mv_2^2 + mgh_2 + \frac{1}{2}kx_2^2$ if you have both gravitational (mgh) and spring ($½kx^2$) potential energies in the problem. Any potential energy terms appropriate to the problem should be included on both sides.

Variables and Units: (Most of these we've defined, but summarizing for the whole equation)

- K_1, K_2: Kinetic energy at state 1 and 2 (J).
- PE_1, PE_2: Total potential energy at state 1 and 2 (J). This could be the sum of gravitational and elastic (and any other conservative) potential energies at those states.
- If broken into specific terms:
  - m (kg), v_1, v_2 (m/s), h_1, h_2 (m), k (spring constant in N/m), x_1, x_2 (spring compression/stretch in m from free length) – all in consistent units such that each term is energy in joules.
- All terms on both sides are energies. In SI, you might have terms like kg·m²/s² (J), and in US units, each term should be in ft·lbf. If you include a term with weight (Wh in lbf·ft), ensure other terms are also in ft·lbf.

Assumptions and Scope:

- *No Non-Conservative Work:* This equation strictly assumes $W_{\text{nc}} = 0$, meaning forces like friction, air drag, or any applied pushes/pulls that don't store energy are absent, or their net work is zero. If there is a mention of "smooth", "frictionless", "ideal" in the problem, that's a cue you can use energy conservation safely.
- *Closed System (Mechanically):* We assume the system is not gaining or losing mechanical energy to the environment. For instance, if a mass is attached to a spring, and it's just oscillating, mechanical energy stays constant (ignoring tiny air resistance). But if someone is pushing it or a damper is present, energy is not conserved.
- *Instantaneous States:* This applies to comparing *any two instants* for which the above conditions hold. They don't have to be beginning or end of motion; they can be any two convenient points (e.g., just after release and at max speed, etc.).
- *All Relevant Energies Accounted:* Ensure all forms of energy in the system are included. In a multi-object system, sometimes gravitational potential for each mass, etc. For FE Mechanical, usually it's one object or objects moving together, so one mgh etc. If a pulley or something is involved and if its mass is negligible, you might ignore its energy, etc., as instructed.

Limit Tests (Sanity Checks):

- **Identical States:** If state 1 and state 2 are the same (no motion, same position), then each term is equal and the equation trivially holds ($0 = 0$). Boring check, but shows it's self-consistent.
- **Free Fall Example:** Take $h_1 = H$, $v_1 = 0$ (object initially at rest at height H), and $h_2 = 0$ (ground), solving for v_2. Energy cons: $0 + mgH = ½mv_2^2 + 0$. Cancel m (assuming $m \neq 0$), get $v_2 = \sqrt{2gH}$. This matches the

basic physics equation from kinematics. If you do it the work–energy way with gravity's work, you'd get the same. It's a nice check that at least in simple cases it reproduces known results.

- **Spring & Gravity Together:** Suppose a mass starts at some height compressing a spring, then you release it and ask how high it goes when it leaves the spring. You can set up an energy equation including both mgh and $½kx^2$ terms at bottom and top. If you plug numbers back and forth (like if it returns to initial configuration, all terms match), energy is consistent. If any term is neglected, the balance wouldn't hold.

Dimensional Check: Every term has dimensions of energy. If one term had a wrong unit in your setup (say you accidentally put a force in place of an energy), the equation's units wouldn't all match. For instance, if you see a mix of J and J/s in one equation, that's wrong (power mixing with energy). So ensure you're not mixing a power or force term into an energy equation.

Use vs. Sibling Equations: Use **energy conservation** instead of the general work–energy equation when you are confident no non-conservative forces do net work. It simplifies life by eliminating the W_{net} term. However, **do not use** pure energy conservation if there *are* losses or inputs – even small friction means mechanical energy is not perfectly conserved. In those cases, revert to the more general $K_1 + PE_1 + W_{\text{nc}} = K_2 + PE_2$. Think of energy conservation as a special sibling of the full work–energy principle (which itself is a sibling to impulse-momentum, etc.). Another sibling concept is the **First Law of Thermodynamics** in thermodynamics topics – which accounts for heat and work – but for mechanical energy, we assume no heat transfer, only work converting between K and PE.

Common Exam Traps:

- *Forgetting a Potential Energy Term:* If multiple conservative forces are in play (gravity, one or more springs), don't leave any out. For example, if a mass is attached to a spring and also has weight, the total $PE = mgh + ½kx^2$. Missing one will give wrong results.
- *Applying When Not Valid:* The biggest mistake is blindly using $K_1 + PE_1 = K_2 + PE_2$ in a situation where friction or some external work is present. The exam may test this understanding by giving a scenario with a small friction force or asking for work done by friction. If you ignore it and use conservation, your answer will be off. **Always double-check**: "Is energy conserved here? Or is some energy leaving/entering the system via non-conservative forces?" If it's the latter, include a W_{nc} term or handle that work separately.
- *Incorrect Sign on Work terms (if any):* If you are in a scenario with one non-conservative force but attempt a quasi-conservation equation, e.g. $K_1 + PE_1 + (-f_k d) = K_2 + PE_2$, make sure the sign is correct. Many prefer to move it: $K_1 + PE_1 = K_2 + PE_2 + f_k d$ for a friction loss, meaning initial energy had to be higher by $f_k d$ to still end up with the final energies. A sign mistake here can lead you to think energy is gained magically or overly lost.
- *Mixing up States:* Sometimes students swap state 1 and 2 inadvertently in the equation or mix values (using, say, v_2 with h_1 in one term). Write the equation carefully and label each term with the state it belongs to. It can help to literally write two columns: one for state 1 energies, one for state 2 energies, and then set equal.
- *Partial Application:* If only part of the motion is conservative and then something changes, you may need to break the problem. For example, object sliding on frictionless then hitting rough patch – energy is conserved until rough patch, then you have losses. Don't try to do one equation across the whole thing without accounting for the middle part correctly.

Footnotes:

- *Mechanical Energy vs Total Energy:* Be aware, "energy conservation" in physics can also include other forms (thermal, chemical, etc.). Here we explicitly mean **mechanical energy** (motion + position forms) is conserved. If the problem implies conversion to heat (friction) or other forms, then mechanical energy is not conserved (though total energy including heat is, but that's outside our scope).

- *Pendulums and Oscillations:* A classic conservative system example is a pendulum (ignoring air drag). At the highest point, all energy is PE, at the lowest, all is K. The swing demonstrates continuous energy conversion with constant total $K + PE$. Expect such examples in conceptual questions.

- *Defining the System:* If a problem involves multiple objects exchanging energy (like a pulley lifting a mass), you can often treat them together as one system for energy. For instance, mass m_1 falling and mass m_2 rising connected by a rope – if no friction, m_1 loses PE, m_2 gains PE, and maybe they both have K. If one object's PE decreases while another's increases, the equation will naturally account for that. Just be careful to include all moving parts' energies.

- *When in Doubt, Go General:* If you are unsure whether energy is conserved, use the generalized work–energy equation: $K_1 + PE_1 + W_{\text{nc}} = K_2 + PE_2$. Then set W_{nc} to zero if you conclude it's negligible. This way you won't accidentally ignore a term. The exam might sometimes indirectly include a non-conservative force by phrases like "including drag" or "rough surface". They usually make it clear.

Variations and Related Forms:

- *Including Rotation in Energy Conservation:* If you have a rolling object or rotating machinery with no losses, you can extend energy conservation to include rotational energy. For example, a rolling ball down a hill (no slip, no air resistance) – you'd include $½I\omega^2$ in K for each state. The equation becomes $½mv_1^2 + ½I\omega_1^2 + mgh_1 = ½mv_2^2 + ½I\omega_2^2 + mgh_2$. (And you might use $\omega = v/r$ if needed to relate them.) This is still conservation of mechanical energy, just with more terms.

- *Multiple Objects:* If two objects interact conservatively (e.g., two masses on a spring), energy conservation can be applied to the system. For instance, a lighter mass and heavier mass connected by a spring (ideal, no friction): one loses kinetic energy while compressing the spring, which is stored as spring potential, then maybe transferred to the other mass as kinetic – throughout, $K_{\text{mass1}} + K_{\text{mass2}} + PE_{\text{spring}}$ remains constant.

- *Energy Diagrams:* Sometimes it's useful to think in terms of energy curves – e.g., for a given system, the potential energy as a function of position and the kinetic energy as the remainder of total energy. The lowest points of potential curves correspond to fastest motion (all K), etc. While you likely won't draw these on the exam, conceptually they help in understanding stability and motion extents (like how high something will rise given initial energy).

- *Conservation of Energy vs Newton's Laws:* Some problems can be solved either by energy or by Newton's second law + kinematics. For instance, finding the speed at the bottom of a frictionless incline: energy method (quick) vs. find acceleration via $F = ma$ down incline, then use $v^2 = v_0^2 + 2as$ (longer). Both yield the same result ($v = \sqrt{2gh}$). The exam tends to favor energy or momentum methods for their simplicity in appropriate situations. But always pick the method you're most comfortable and confident with under time constraints, as long as it applies.

- *Non-Conservative Work Included:* It's worth re-emphasizing a related form: if a non-conservative force (like friction) is present but you still want to use an energy approach, you can modify the conservation equation to: $K_1 + PE_1 + W_{\text{nc}} = K_2 + PE_2$. This is essentially the full work–energy equation, just splitting W_{nc} (work of non-conservative forces) to one side. If friction does -500 J of work (energy loss), you'd put -500 J in for W_{nc}. If an engine does +500 J of work, $W_{\text{nc}} = +500$ J. This one equation can handle everything; pure conservation is just the case $W_{\text{nc}} = 0$.

Explanation & Analysis (How to Apply Conservation of Energy): This method is one of the fastest ways to solve a suitable dynamics problem. Here's how you typically use energy conservation on the FE exam:

1. **Decide if Applicable:** Read the problem and identify forces. If you see *"frictionless", "no air resistance", "smooth pulley", "elastic collision (no energy loss)"* or just a situation with only gravity and springs, that's a green light for energy conservation. If you detect any mention of friction, deformation, or "power input", either avoid energy conservation or plan to include a work term for those.
2. **Write Down Total Energy at State 1:** $E_1 = K_1 + PE_1$. Write expressions for each:
   $K_1 = ½mv_1^2$. If initial speed is zero, this term is 0.
   PE_1 might be mgh_1 (if gravity) plus $½kx_1^2$ (if a spring is compressed/stretched) and so on. Include all relevant conservative potentials.
3. Use a consistent reference for potential energies. For gravity, pick a zero height (perhaps the lowest point in motion or ground). For springs, typically zero potential at natural length ($x = 0$).
4. **Write Down Total Energy at State 2:** $E_2 = K_2 + PE_2$, similar breakdown at the final state of interest. Often state 2 is where you want to find something (e.g. velocity or height).
5. **Set $E_1 = E_2$:** Equate the two expressions. This equation alone often is enough to solve for the unknown. For example, if a block slides down and you want velocity at bottom: $mgh_1 + 0 = ½mv_2^2 + 0$ (assuming you set bottom height as zero and it starts from rest up top). Solve for v_2. Done.
6. **Cancel Common Factors:** Mass m appears in every term of many energy equations, so often it cancels out entirely. This is a nice perk: the speed from a given height doesn't depend on mass (in the absence of friction) – a point often tested conceptually. If you find mass still in your equation at the end and you had a pure gravity problem, double-check; maybe it should cancel.
7. **Solve for Unknowns:** The unknown could be a velocity (v), a height (h), a spring compression (x), etc. Because energy equations are often quadratic (due to v^2 or x^2 terms), be mindful: you might get two possible solutions (e.g., $v = \pm 10 m/s$). Obviously, pick the physically meaningful one (e.g., positive speed magnitude).
8. **Interpret the Result:** If the question is conceptual (like, "which will be faster at bottom, a frictionless slide or a free-fall of same vertical drop?"), energy conservation quickly tells you they'll be the same $v = \sqrt{2gh}$ (assuming both start from rest). If the question asks for work done by friction, you could compute via energy difference: compare E_1 and E_2 – the lost mechanical energy is exactly the work done by friction (negative work). For example, if without friction you'd have 100 J at bottom but you only got 60 J of K, then friction took 40 J (which you could also find via $f_k d$).
9. **Check Extremes:** If one of the states is an extreme (like max height reached where $v = 0$, or max compression where motion momentarily stops), then one of the K terms is zero there. That simplifies the equation. Use such insights to sanity-check: e.g., at max height, all energy is potential; at lowest point, perhaps all is kinetic (if chosen datum).
10. **Partial Segments:** If motion occurs in stages (say part frictionless, part with friction), you might apply energy in segments. For example, from A to B (frictionless) use conservation; from B to C (with friction) use work–energy. Or better, stick to one general equation including friction's work for the whole A to C. But if that's complicated, breaking it is fine – just carry the intermediate result carefully.

In summary, conservation of energy is your **go-to approach for idealized problems** on the FE exam where no energy is dissipated. It's quick, reliable, and bypasses a lot of unnecessary complication. Just be vigilant for when it doesn't apply, and then switch to the more general work–energy with a W_{nc} term. With practice, you'll identify at a glance which problems practically solve themselves with $K_1 + PE_1 = K_2 + PE_2$.

K07.T04.S04 – Power and Efficiency in Work–Energy Calculations

Principle Introduction (Intuition & Setup): In mechanics, **power** and **efficiency** are concepts related to work and energy that often appear in machine or engine problems. While work and energy tell us "how much" energy is transferred or transformed, **power** tells us "how fast" that work is done (the rate of energy transfer). **Efficiency**, on the other hand, tells us "how effectively" energy is converted from one form to another, typically comparing output to input. Key insights:

- **Power = Work per Time:** If you do a certain amount of work, power measures how quickly it was done. Lifting a weight slowly vs. quickly requires the same work (same change in PE), but the quick lift demands more power. In the context of engines or motors, power is their rate of doing work or delivering energy (e.g., an engine might do 1000 J of work every second, so 1000 W).
- **Instantaneous Power (Force · Velocity):** A useful relation: when a force F is acting on an object moving at velocity v, the instantaneous power delivered by that force is $P = F \cdot v$ (more precisely $P = \mathbf{F} \cdot \mathbf{v}$, the dot product of force and velocity). This is essentially dW/dt. It means if you know the force pushing something and how fast it's moving, you can find how much energy per second is being transferred.
- **Efficiency = Useful Out / Total In:** Machines are never perfect – some input energy is always lost (to heat, sound,

etc.). **Efficiency (η)** is a dimensionless fraction or percentage that indicates what portion of input energy (or power) is converted to desired output work (or power). For instance, if a motor uses 100 J of electrical energy to do 80 J of mechanical work, its efficiency is $80/100 = 0.8$ or 80%.

- **Why Efficiency Matters:** On the FE exam, you might encounter problems like: given an input power and an efficiency, find the output power (or vice versa), or calculate how much power is lost to inefficiency. Efficiency ties directly into energy calculations: if you know a machine's efficiency, you can figure out how much energy is wasted versus delivered.
- **Units and Typical Values:** Power is measured in watts (W) in SI, where 1 W = 1 J/s. In US units, power might be given in horsepower (hp) or ft·lbf/s. 1 hp = 550 ft·lbf/s = 746 W. Efficiency is usually given as a percentage or a decimal less than 1. No real machine is 100% efficient. Typical mechanical efficiencies: electric motors ~90%, gasoline engines ~20–30%, pulleys maybe 98% (losses to friction), etc. Efficiency can also refer to specific definitions (thermal efficiency, etc., in thermo context), but on the mechanical side it's generally output work over input work.

Exam Handbook Search Cues (Not affiliated with or endorsed by NCEES): *"power", "work/time", "horsepower", "efficiency", "output/input"*

Equation Passport – Power – quantifies the rate of doing work or transferring energy. This formula connects work done to the time taken, giving a measure in watts:

- **Professional Equation:** $P = \frac{W}{\Delta t}$ where W is work (or energy transferred) and Δt is the time interval in which that work is done. For instant power at a moment, $P = \frac{dW}{dt}$.

Additionally, if a force F moves an object at velocity v, $P = F\,v\cos\theta$, where θ is the angle between the force direction and velocity direction (so $F\cos\theta$ is the component of force doing work). In the simplest case of force aligned with motion, $P = Fv$.

Variables and Units:

- P: **Power** (SI unit: watt, W, where 1 W = 1 J/s; in USCS, often hp or ft·lbf/s. 1 hp ≈ 746 W).
- W: **Work** or energy (joules, J). This could be any energy transferred – mechanical work, electrical energy, etc., as long as it's quantified in joules.
- Δt: **Time interval** during which the work is done (seconds, s).
- F: **Force** (newton, N; or lbf in US). If using $P = Fv$, be sure F is the component of force in direction of motion.
- v: **Velocity** of the point of application of the force (m/s; or ft/s). If multiple forces, you could have each doing power $F_i v_i$ and sum them for net power input or output.

Assumptions and Scope:

- The formula $P = W/\Delta t$ assumes a constant or average rate over Δt. If power varies, you'd use calculus ($P(t) = dW/dt$) but FE problems usually keep it simpler with steady or average values.
- $P = Fv$ assumes a steady force and velocity at that instant. If either changes, you might again consider instantaneous values or average over a cycle.
- We assume the motion and force are in a straight line for simplicity. If not, use the component of force in direction of motion as noted.
- Pay attention to whether the power in question is **input power or output power** of a system, and what does the work W represent (e.g., work output by a motor vs electrical energy input to it). This ties into efficiency next.
- Also assume no relativistic effects – at extremely high speeds, definitions get tricky, but that's beyond FE scope.

Limit Tests (Sanity Checks):

- **No Work, No Power:** If $W = 0$ (nothing done), then $P = 0$. Also if Δt is extremely large for a fixed amount of work, P approaches 0 (doing a task very slowly yields very little power output).
- **Time → 0:** For a fixed work, as $\Delta t \to 0$, $P \to \infty$. This is like delivering a jolt of energy in a split second (very high power for a short time, e.g. a camera flash). In reality there might be limits, but mathematically power can be very high if time is very short.
- **Units:** 1 N acting over 1 m in 1 s does $W = 1$ J in 1 s, so $P = 1$ J/s = 1 W. If the same 1 J is done in 0.5 s, $P = 2$ W. If done in 2 s, $P = 0.5$ W. This checks out with intuition.
- **Force–Velocity Example:** If a 100 N force moves an object at 3 m/s, $P = 100 * 3 = 300$ W. If the same force isn't aligned (say 100 N at 60° to direction of motion), power is $100\cos 60° * 3 = 150$ W. If velocity is zero (object not moving), $P = 0$ even if force is applied (no work is being done because no distance is covered).

Use vs. Sibling Equations: Use the power formula whenever you need to relate work to time or find how much work can be done in a given time (or vice versa). It's especially handy in **engineering economics of machinery** (like, how big a motor (in kW or hp) is needed to lift an elevator of a certain weight at a certain speed). **Do not confuse** power with torque or force: they're related (torque times angular speed gives power in rotation, $P = \tau\omega$). Also don't confuse power with energy: power is the rate, energy is the quantity. Many errors happen by equating a power equation with an energy equation incorrectly (e.g., setting $Fv = ½mv^2$ directly – that's mixing an instantaneous power with an energy; instead, Fv integrated over time yields energy).

A sibling concept is **power in electrical systems** (P=VI), but in mechanical work terms, $P = W/t$ is our main tool. Another sibling formula: **work-energy principle** integrated over time essentially gives power: $P_{\text{net}} = dK/dt$ for particles (the time derivative of kinetic energy is net power input).

Common Exam Traps:

- *Mixing Units for Power:* Keep track if power is given in horsepower or watts. If a pump is rated at 5 hp and you need to use it in an equation with SI units, convert 5 hp to watts (≈ 3730 W). Conversely, if you compute power in watts and the answer needs horsepower, divide by 746. The exam may expect familiarity with this conversion.
- *Peak vs Average Power:* Sometimes a problem might imply an average power (total work over total time), but

students might mistakenly use an instantaneous scenario. For example, accelerating a car from 0 to 60 mph in 10 s – the work done on the car is ΔK, and average power would be $\Delta K/10$ s. The instantaneous engine power might not be constant. If the problem doesn't specify, assume average unless it clearly says constant power.

- *Forgetting Efficiency:* If a problem gives you the **input power** of a machine and asks for some result that involves output (like how quickly it can lift a weight), you must incorporate efficiency. If you neglect it, you'll likely overestimate the output. For instance, a motor of 2 kW at 70% efficiency only delivers 1.4 kW of mechanical work output – the rest (0.6 kW) is wasted as heat.
- *Direction in $P = Fv$:* Remember Fv really means $\mathbf{F} \cdot \mathbf{v}$. If force opposes motion (like friction on a moving object), then F and v are opposite directions, $\cos 180° = -1$, and that force actually has **negative power** (it's removing energy from the system). Negative power just means that force is doing work *on* the object in reverse (or the object is doing work against that force). For instance, friction *consumes* mechanical energy at a rate fv as heat.
- *Power vs Torque:* A common confusion in rotating systems: a motor's torque is not power by itself. Power in rotation is $P = \tau\omega$. If the exam gives a motor's torque and rotational speed, use that formula. Don't mistakenly multiply torque by linear speed unless you've converted properly (if a wheel of radius r has torque τ and rotates at ω, linear speed at rim $v = \omega r$, and indeed $P = \tau\omega = F_{\text{rim}}v$ with $F_{\text{rim}} = \tau/r$).

Equation Passport – Efficiency – **measures the fraction of input power (or energy) that is converted to useful output.** It's usually denoted by the Greek letter eta, η:

- **Professional Equation:** $\eta = \frac{\text{Output Power}}{\text{Input Power}} = \frac{\text{Output Work}}{\text{Input Energy}}$ (over the same time period).

In percentage terms, $\eta(\%) = \frac{\text{Output}}{\text{Input}} \times 100\%$.

If dealing with energies, say W_{out} from W_{in} in a process, the formula is the same form $\eta = W_{\text{out}}/W_{\text{in}}$, provided both are measured over the same process or time.

Variables and Units:

- η: **Efficiency** (a dimensionless ratio, often expressed as a decimal or percentage; no units).
- Output Power/Work: The useful power or work delivered by the system (could be mechanical work output, like lifting a weight, or shaft power delivered).
- Input Power/Work: The power or energy supplied into the system (could be electrical power into a motor, fuel energy in an engine, etc.).
- Both output and input should be in the same units for the ratio to make sense (J/J for energy, W/W for power, etc.), so the units cancel, leaving a pure number.

Assumptions and Scope:

- Efficiency is always between 0 and 1 (or 0% to 100%) for real processes. 1 or 100% means perfectly efficient (no losses, extremely rare or ideal limit), 0 means no useful output at all.
- The formula assumes you clearly define what is input and what is considered output (the "useful" part). For example, in a car engine, input might be chemical energy of fuel, output might be mechanical work on wheels. But if the question specifically asks for "thermal efficiency" vs "overall efficiency", be sure to use the right energies. In pure mechanics problems, usually it's straightforward: input work vs output work.
- Efficiency can refer to a single machine or an entire system. Sometimes efficiencies of components multiply (e.g., a motor driving a gearbox: if motor is 90% and gearbox 80%, overall is 0.9*0.8=0.72 or 72%). The exam might test such chaining.
- We assume steady operation for power ratios. If dealing with energy of one cycle or one lift, you can use work directly.

Limit Tests (Sanity Checks):

- **Perfect Machine (Hypothetical):** $\eta = 1.0$ or 100% means output equals input. If a question says "neglect losses" or something, you might treat efficiency as 100% for simplicity. But any other case should have $\eta < 1$. If you calculate an efficiency >100%, something's wrong (you either overestimated output, underestimated input, or compared the wrong quantities).
- **No Output:** If the output is zero (machine doing nothing useful with the energy), $\eta = 0$. For example, an idling engine that just burns fuel without moving a load has near 0% mechanical efficiency (all energy wasted as heat and noise).
- **Units:** Since efficiency is unitless, if you calculate an efficiency and get something with units, you probably divided the wrong things. E.g., if you accidentally did output power (W) over input energy (J), you'd get 1/s which is not right. Make sure it's W/W or J/J type.
- **Small differences matter:** If a motor outputs 90 W from 100 W input, $\eta = 0.90$. If it outputs 95 W from 100 W, $\eta = 0.95$. The difference may seem small, but that extra 5% means half the losses compared to the 90% case. Efficiency tends to have diminishing returns near the high end, but those are significant improvements in engineering terms. On the lower end, say 30% vs 20%, that's a big gap (the 20% machine wastes 80% of energy; the 30% wastes 70%, which is a 12.5% absolute increase in output fraction).

- **Use vs. Sibling Equations:** Use the efficiency equation whenever you're dealing with input vs output of a system. For example, **use it to** find how much input is required for a desired output: $W_{\text{in}} = \frac{W_{\text{out}}}{\eta}$. Or to find output for given input: $W_{\text{out}} = \eta W_{\text{in}}$. **Do not confuse** efficiency with effectiveness of other kinds (like the efficiency of an algorithm in computing – irrelevant here). Also, distinguish efficiency from **duty cycle** or other percentages – efficiency specifically relates energy in to energy out. Another sibling concept is **mechanical advantage** (in statics, ratio of output force to input force in simple machines) – not the same as efficiency because mechanical advantage doesn't account for energy loss, it's just force multiplication ignoring distance moved. Efficiency would account for energy (force*distance) differences.

Common Exam Traps:

- *Not Using Efficiency When Required:* A classic scenario: "A motor lifts a 100 kg crate at 2 m/s. If the motor is 80% efficient, what input power is required?" If you ignore efficiency, you'd compute $P_{\text{ideal}} = Fv = mg2$ *(which is* $1009.81 * 2 \approx 1962$ W) and that would be the output power (to lift the load). But the input power must be higher due to 80% efficiency: $P_{\text{in}} = P_{\text{out}}/0.8 \approx 2452$ W. Students who neglect efficiency might answer 1.96 kW instead of the correct ~2.45 kW.
- *Mixing efficiencies of different domains:* If a problem has multiple efficiency stages, handle them one by one. For example, an engine (chemical to mechanical) and a generator (mechanical to electrical) in series, each with their efficiency. Don't average them or anything; use the chain: overall $\eta = \eta_1 * \eta_2$. Also, be careful if they give efficiency in percent, convert to decimal in calculations (e.g. 75% as 0.75).
- *Confusing power and energy in efficiency:* If a process is not steady, sometimes you have to compare energies for one cycle or one event. But usually, FE will give steady or a clear time basis. If it says "per hour" or such, ensure you compare energy per hour out vs in. If everything is per second (power), you're fine. Just be consistent.
- *Rating vs Requirement:* Some devices are rated by output. For example, a "5 kW pump at 70% efficiency" presumably can output 5 kW of mechanical work in the fluid. That means it likely draws about 7.14 kW electrical. Conversely, a "5 kW motor, 85% efficient" might mean 5 kW input draws, delivering 4.25 kW output. The wording can be tricky; check context or any standard convention. On the exam, they typically clarify or expect you to ask: output or input? You may need to deduce from context (e.g., if it's a pump, probably 5 kW output to water).

Footnotes:

- *Brayton vs Rankine vs Mechanical Efficiency:* In thermo cycles, there are specific definitions (thermal efficiency of a cycle, mechanical efficiency of an engine's components, etc.). In Mechanical FE, you're mostly dealing with straightforward mechanical or overall efficiency. If a question references, say, pump efficiency or motor efficiency, it's output mechanical energy vs input electrical or fluid energy. If it's unclear, assume they mean overall energy conversion efficiency.

- *Pump & Motor Example:* A pump might have $\eta_{\text{pump}} = \frac{\text{water power out}}{\text{shaft power in}}$. A motor has $\eta_{\text{motor}} = \frac{\text{shaft power out}}{\text{electric power in}}$. If you have an electric motor driving a pump, and they give both efficiencies, overall $\eta = \eta_{\text{motor}} * \eta_{\text{pump}} = \frac{\text{water power}}{\text{electrical power}}$. The FE exam loves these chain efficiency problems in the mechanical section.

- *Power in Braking:* Note that power is also used in context of things like braking or dissipation – e.g., "what power must be dissipated by the brakes to slow a vehicle?" You'd calculate the change in kinetic energy and divide by the time over which it's dissipated. That gives heat generation rate (which might be huge for quick stops). Efficiency isn't really used there (the brakes basically convert kinetic to heat ~100% efficiently as that's their job).

- *Human Power:* Occasionally you might see context like "a person can produce about 75 W of power sustained" or something in an engineering econ or design context (for like, can a person power this device by pedaling?). Just an interesting reference: 1 hp is a lot for a human (we can do maybe 0.1 to 0.3 hp for extended periods). Efficiency of human muscles is roughly 20-25% (food energy to mechanical output).

Variations and Related Forms:

- *Power in Rotational Systems:* We hinted at it: $P = \tau\omega$ for rotation (where τ is torque, ω in rad/s). This is analogous to Fv. If dealing with a motor or engine giving a torque at certain rpm, you can calculate power. This might show up in a question about, say, a winch: torque on the drum and its angular speed give power output, which compared to motor input gives efficiency.

- *Hydraulic Power:* Fluid systems might give power in terms of flow and pressure: $P = Q\Delta p$ (with proper units: Q volumetric flow, Δp pressure drop, P in Watts if Q in m³/s and Δp in Pa). If you see something like pumping power, that's a formula you might recall. It's basically work done per time = force*distance/time (pressure * volume/time). Efficiency of a pump then relates that to shaft power in.*

- Electrical vs Mechanical: *Since FE is broad, sometimes a mechanical problem might cross into electrical: e.g., a lifting crane with an electric motor – you might need to use motor's electrical input (P = VI perhaps) and mechanical output (*mgh/t*) to find efficiency or current draw. Keep track of forms: mechanical power output = electrical power input * efficiency (for a motor).*

- Energy over Time: *Efficiency can also apply to one-time energy use: if it takes 5000 J from a battery to lift an object that gains 4000 J of potential energy, the efficiency for that task was 80%. It's the same fraction, just not per second. Usually in machines we use power because they operate continuously, but energy form is fine for single processes.*

- Brake Power vs Indicated Power (engines): Mechanical engineering specifics: in engines, "brake power" is output at shaft, "indicated power" is theoretical inside cylinders, and mechanical efficiency is brake/indicated. These specifics probably won't be directly asked unless you studied engines, but just note that within the machine, different stages have their own "efficiencies." The exam tends to stick to overall or simple component efficiency.

Explanation & Analysis (Using Power and Efficiency):

- **Using Power in Problems:** If a question gives you a time and an energy or work, you should think power = work/time. For example: "How long will it take a 2 kW motor to lift a 500 kg crate by 10 m (assume ideal, no losses)?" First, find work needed: $W = mgh = 5009.8110 = 49{,}050$ J. The motor provides 2000 J/s. Time $= W/P = 49050/2000 = 24.525$ s ≈ 24.5 s. If the motor's efficiency was 100%, that's the answer. If it were 80%, actually the output power is only 0.8*2000 = 1600 W lifting, so time would be* $49050/1600 \approx 30.7$ *s because some power is wasted.*

- *Determining Efficiency from Data: Suppose a problem says: "A certain machine requires 500 J of input to accomplish 350 J of useful work. Where did the rest go?" It implies efficiency* $350/500 = 0.70$ *or 70%, and the rest (150 J) presumably went into heat, sound, etc. On the exam, they might directly ask the efficiency given those numbers, or ask how much energy was lost. Just subtract input minus output.*

- *Incorporating Efficiency in Work–Energy problems: Efficiency often comes into play after you've figured out an ideal work or power requirement. For instance, you might use energy*

conservation or work calculations to find that "15,000 J of work is needed to raise this elevator", and then the question might ask, "If the motor is 85% efficient, how much energy does it actually draw from the electrical supply?" You'd do $15{,}000/!\,0.85 =$ $17{,}647$ J (approximately). *Similarly for power: if you need 5 kW output and efficiency is 0.9, input must be* $5/0.9 \approx 5.56$ *kW.*

- *Multiple Efficiencies: If multiple stages, handle sequentially. For example, an engine (25% efficient converting fuel to shaft work) drives a generator (90% efficient converting shaft to electricity). Overall from fuel to electricity = 0.25*0.90 = 0.225 (22.5%). If the question: "Fuel releases 1000 J per cycle, how much electric energy is produced per cycle?" Answer: $1000 * 0.225 = 225$ J.

- **Power vs Torque example:** A crane's winch needs to lift at 0.5 m/s a load of 2000 N (roughly ~204 kg). That's output power $P_{\text{out}} = Fv = 20000.5 = 1000$ W. *If the motor driving it is 70% efficient, input electrical power must be about 1429 W. If instead they told you the motor draws 2 kW, and asked for the speed it can lift 2000 N, you find output = 0.7*2000 = 1400 W, then $v = P/F = 1400/2000 = 0.7$ m/s.

- **Understanding "losses":** Efficiency problems sometimes implicitly give you losses. E.g., "The motor produces 10 kW of output while 2 kW is lost as heat. What is its efficiency?" You see total input must have been 12 kW (since 2 was wasted, 10 useful), so efficiency = 10/12 ≈ 83.3%. Or they might say "friction losses are 30%" meaning only 70% goes to output (efficiency 70%).

- **Interpreting Data Plates or Ratings:** If a pump is rated 10 kW, check context if that is the required input or the output capability. Usually, pump rating refers to output (the hydraulic power). If combined with an efficiency figure, you find input. If they instead just give motor power and efficiency, find output. This is a bit contextual, so read carefully any wording around it.

- **Units check in answers:** If asked for power, give in watts or hp as required (they might explicitly say "in kW" or "in hp"). For efficiency, give percentage if asked that way (the exam might accept either .XX or XX%). Just be clear.

- **Edge Cases:** Efficiency could appear in combination with energy conservation: e.g., a pendulum swings and rises to some height less each time due to air resistance. If they gave an efficiency per swing (say it retains 90% energy each swing), you could find how high it goes after each swing by multiplying energy by 0.9 etc. That's a more conceptual use of efficiency as a ratio of conserved energy.

Power and efficiency are straightforward but critical for any scenario involving machines or energy conversion. They often link the theoretical calculations to real-world constraints (no machine is ideal). In the FE exam, once you compute the ideal requirement using work–energy, **don't forget to adjust for efficiency** if the problem mentions it. It's typically the last step – and it can turn a correct calculation into an incorrect answer if overlooked.

Topic 05 - Impulse–Momentum

Topic Introduction: Impulse–momentum principles connect force, time, and motion. In this chapter, we explore how forces acting over time intervals (impulses) produce changes in momentum (both linear and angular), and how to analyze collisions using momentum conservation. This topic is crucial for the FE Mechanical Exam because many problems involve forces that act briefly (like a hammer strike or a collision) where energy methods might not apply directly. The impulse–momentum approach simplifies such problems by bypassing complex kinematics or differential equations – instead, you integrate forces over time or use momentum conservation. Typical question archetypes include finding the velocity of an object after a force is applied for a given time, determining the outcome of two bodies colliding (elastic vs. inelastic), or computing the effect of a torque impulse on a rotating mass. Mastering these concepts ensures you can confidently tackle **Dynamics** problems where timing and forces interact (e.g. vehicles braking, objects dropping and bouncing, or rotating machinery subjected to sudden loads).

K07.T05.S01 – Linear Impulse–Momentum Theory

Principle at a Glance: When a net force acts on a particle over a time interval, it produces an impulse that equals the change in the particle's linear momentum. In other words, force "accumulated" over time changes how fast (and in what direction) the mass is moving. This is essentially Newton's second law integrated over time:

- **Impulse** is defined as the integral of force with respect to time ($\int F\,dt$) – it represents the "area" under a Force–time curve. Even a small force can have a large effect if applied for a long duration.

- **Linear momentum** is the product of mass and velocity ($m\,v$). A change in momentum ($m\,\Delta v$) directly corresponds to acceleration over time (via $F = ma$) but is often easier to use when time and force are involved together.

- **Impulse–momentum applications:** This principle is especially useful for solving problems where forces are not constant or where we care about the cumulative effect of a force (e.g. finding launch velocity after a push, or stopping distance given a braking force). It avoids needing the acceleration at every moment – we focus on the initial and final states. - Always **choose a consistent direction as positive** before applying the impulse–momentum equation. Momentum and impulse are vector quantities; we typically break the problem into components (e.g. x and y) and apply the principle in each direction independently.

- If **multiple forces** act, you can sum all their impulses over the time interval (superposition). Likewise, for a system of particles, you can sum the momenta of all parts – the total impulse on the system equals the total momentum change of the system (provided no external mass enters or leaves).

Exam Handbook Search Cues (Not affiliated with or endorsed by NCEES): *impulse*, *momentum*, *linear momentum*, *impulse-momentum theorem* (use these terms to find relevant formulas in the exam reference).

Equation Passport: Linear Impulse–Momentum Theorem – relates the impulse from a net force to the change in linear momentum of a particle (or system of particles).

- **Name and purpose: Linear Impulse–Momentum Theorem** – computes the change in an object's linear velocity from a force applied over time. It answers questions like "How fast will it go after this force acts for this long?" by equating force–time impulse to momentum change.
- **Formulation (professional equation):** $\sum_{t_1}^{t_2} F\ dt\ =\ m\,v_2\ -\ m\,v_1$, which is often written as $\mathbf{J} = m\,\Delta\mathbf{v}$, where the left side **J** is the *impulse* (integral of net force from time t_1 to t_2) and the right side is the change in momentum $m(v_2 - v_1)$. (This is a vector equation; apply it along each axis as needed.)

Variables and units:

- F – net force acting on the particle in the chosen direction (units: N (SI), or lbf (US)). This can be a function of time $F(t)$ if the force varies.
- t – time (s). The integration from t_1 to t_2 covers the duration of interest.
- m – mass of the particle (kg in SI; slugs in US customary units if using F in lbf).
- v_1, v_2 – initial and final velocity of the particle (m/s (SI); ft/s (US)) in the chosen direction. $m\,v$ is the linear momentum (kg·m/s).
- $\sum_{t_1}^{t_2} F\ dt$ – **impulse** delivered by the net force over time interval $[t_1, t_2]$ (units: N·s, which is equivalent to kg·m/s in SI). If multiple forces act, their impulses add (vectorially).

Assumptions and scope:

- Mass m is **constant** during the interaction (no rockets burning fuel or objects splitting apart during the interval).
- The equation holds for a **particle** or an entire system of particles (using net force and total mass *if* mass is constant and no external mass transfer). For a system, $m\Delta v$ represents total momentum change of the system.
- Valid for any force–time history: force can be constant or variable. If F is constant, $\int F\,dt$ simplifies to $F\Delta t$.
- We consider the **net force in one direction**. If motion is 2D or 3D, apply separately along each axis (e.g., separate equations for x and y components).
- **No other limitations:** This principle is derived directly from Newton's 2nd law, so it's universally applicable in classical mechanics for linear motion, as long as you correctly account for all forces.

Limit tests (sanity checks):

- If the net impulse is zero ($\int F\,dt = 0$), then $m(v_2 - v_1) = 0$, implying $v_2 = v_1$. No net force over time means no change in velocity – consistent with Newton's first law.

- If a **very large impulse** is applied (either a huge force briefly or a moderate force over a long time), the momentum change is very large – the object's velocity will change significantly. This aligns with expectations (e.g., a strong kick or a long push leads to a big speed change).
- **Direction check:** If the impulse is opposite to the initial motion (negative impulse on a positive momentum), the formula will yield a reduced momentum or even a reversed velocity (e.g., throwing a ball upward (positive v) and gravity's impulse slowing it down to 0 at the peak).

Use vs. sibling equations: Use the impulse–momentum equation instead of kinematics or $F = ma$ when dealing with **forces applied over time** or when the force is not constant. This method shines in solving problems that involve **time-dependent forces** (like braking forces that vary, or impulses like kicks and thrusts) or **quick interactions** (like collisions or explosions) where calculating acceleration at each instant is impractical. Compare with the **Work–Energy principle**: use impulse–momentum if time or force duration is involved, or if energy is not conserved (like in inelastic collisions). Use work–energy for finding distance or work done when forces are conservative or energy data is given. Each has its domain – impulse–momentum focuses on forces and time; work–energy focuses on forces and displacement.

Common exam traps:

- **Sign convention errors:** Forgetting that F and v (hence Δv) are vectors. A classic mistake is to plug values without regard to direction. Always assign a positive direction (e.g. to the right or upward) and stick to it. If a force opposes motion, its impulse will be negative in that coordinate system, and it will decrease momentum (and velocity).
- **Unit mix-ups:** In the USCS (English units), ensure consistency. If you use F in pounds-force and mass in slugs, impulse in lbf·s yields momentum in slug·ft/s (which is consistent). *Footnote:* 1 slug·ft/s = 1 lbf·s. However, if mass is given in pound-mass (lbm), you must convert to slugs (by dividing by $g_c = 32.174$lbm·ft/(lbf·s^2)) or use $F = ma/g_c$ form. The exam may avoid such unit-intensive scenarios, but be prepared.
- **Forgetting impulse from weight:** In problems where an object is in motion for a time, don't neglect constant forces like gravity or friction acting during that interval. For example, if a ball is struck upward, gravity provides a downward impulse during the time interval as well. Sum all forces (including weight) to get the net impulse.
- **Mishandling time units:** If time Δt is given in milliseconds or minutes, convert it to seconds in SI calculations. Impulse units must match momentum units.
- **Vector component confusion:** If a force is angled, you should take components of impulse in the relevant direction. For instance, to find horizontal velocity change, use the horizontal component of force for the impulse in that direction.

Footnotes: Keep in mind subtle points like mass vs. weight (especially in US units) – if a problem gives weight (in newtons or lbf), convert to mass for use in $m\Delta v$. Also remember that the impulse–momentum equation is essentially a reformulation of $F = ma$; it does not introduce new physics but packages it in an integral form. If an exam problem seems straightforward with constant acceleration equations, you can use those as well, but impulse–momentum will get you the same answer with a more direct route when force and time are central.

Variations and related forms: In vector form, you might see $\mathbf{p}_2 = \mathbf{p}_1 + \mathbf{J}$, *where* $\mathbf{p} = m\mathbf{v}$ *is momentum and* $\mathbf{J} = \int \mathbf{F}\, dt$ *is impulse. In component form, for example in 2D:*

- $\int F_x dt = m(v_{2x} - v_{1x})$ (horizontal component),

- $\int F_y dt = m(v_{2y} - v_{1y})$ (vertical component).

If an object is subject to a **continuous force** over time (like a rocket thrust), you may integrate piecewise or use average force $\bar{F}$ such that $\bar{F}\Delta t = m\Delta v$ if $\bar{F}$ is known. For **variable forces**, sometimes the exam provides a graph of $F(t)$; the area under the curve is the impulse. Also note, if no external force acts on a system (net $\int F dt = 0$), then $\Delta(mv) = 0$ – this implies **conservation of linear momentum** for that closed system (a special case frequently used in collision problems).

Special notes (calculator usage): The impulse–momentum calculation usually doesn't involve anything more complex than multiplication or integration of simple shapes. If faced with a force–time graph consisting of simple geometric shapes (triangles, rectangles), calculate the area using geometry rather than trying to integrate by formula. Remember that the FE exam's allowed calculators can handle basic integrals numerically, but it's often faster to compute areas by hand for linear or constant segments.

Explanation: The linear impulse–momentum theorem is your go-to tool whenever a problem involves a force exerted over a duration to change an object's speed. Instead of computing acceleration and then velocity (using kinematics), you directly relate the *cause* (impulse from force over time) to the *effect* (change in velocity). For example, if a 1000 N force acts on a 50 kg crate for 3 seconds, the impulse is $1000 \times 3 = 3000$ N·s, which equals the crate's change in momentum. So $50\,\Delta v = 3000$, giving $\Delta v = 60$ m/s. It's a quick way to find the velocity increase without dealing with $a = F/m$ and $v = v_0 + at$ separately. This method is especially powerful in solving **impact problems** or any scenario where forces are transient. It also clarifies that if no net force acts (like a gliding object in space), momentum stays constant.

Analysis: Looking at the equation term-by-term: - The left side $\int_{t_1}^{t_2} F\ dt$ represents the **impulse**. Physically, this is the "punch" delivered by the force. It's the area under the force vs. time curve. A larger area (either from a stronger force or a longer time) means a bigger impulse. - The right side $m(v_2 - v_1)$ represents the **change in momentum** of the mass. Momentum (mv) is often thought of as the "quantity of motion." Changing it requires a push or pull over time. If $v_2 > v_1$, momentum increased in the direction of F; if $v_2 < v_1$, momentum decreased, meaning the impulse of F was opposite to the motion. - The equality means **impulse = change in momentum**. This encapsulates Newton's second law in integral form. It's valid even if F varies in time, as long as you correctly integrate. - Always double-check units: a Newton-second is the same as a kg·m/s, so the equation is homogeneous in units. In U.S. units, a lbf·s is the same as slug·ft/s, ensuring consistency if you've used slugs for mass. - **Common sense check:** If the force acts in the opposite direction of motion, you expect the object to slow down. The equation will yield a negative Δv in that case. If you accidentally plug the wrong sign for force or Δv, you might get an answer that defies intuition (like an object speeding up when a

braking force was applied). Use the equation with awareness of direction: if your result's sign or direction is opposite of what you expect physically, recheck the sign convention step.

K07.T05.S02 – Angular Momentum of a Particle & Angular Impulse–Momentum

Principle at a Glance: Just as linear momentum deals with straight-line motion, **angular momentum** deals with rotational effect of a particle about a point (or axis). For a particle moving in a plane, the angular momentum about some reference point O is defined as $H_O = m\,v\,r_\perp$ (mass × speed × perpendicular distance to the point). This measures how much "rotational motion" the particle has about O. When a net moment (torque) acts on the particle about that point over time, it produces an **angular impulse** that equals the change in angular momentum about that point. In formula form, $\int M_O\,dt = \Delta H_O$ – completely analogous to the linear case, but with moments and angular momenta.

Key points include:

- **Angular momentum (H)** is the rotational analog of linear momentum. For a single particle, think of it as the "moment" of its momentum about a point. For example, a high-speed particle far from point O has a large H_O; if it passes closer or slows down, H_O decreases. It's given by $H_O = \mathbf{r} \times m\mathbf{v}$ (a vector perpendicular to the plane) or simply mvr in magnitude when **r** and **v** are perpendicular.

- **Angular impulse** is the time-integral of moment (torque). If you apply a moment M_O (e.g., a force at some lever arm from O) over a time interval, you've imparted an angular impulse $\int M_O dt$. This changes the angular momentum about O, just as a force impulse changes linear momentum.

- **Conservation of angular momentum:** If no net external moment acts about a point (i.e. $\int M_O dt = 0$), then angular momentum about that point is conserved (constant). This principle is widely applicable – from particles moving in central force fields to objects like satellites or even figure skaters (though the latter involves rigid bodies). In exam problems, you might use it if, say, a particle moves without any torque about a certain point, or during collisions where no external torque is applied about the center of mass. - This concept often appears in **systems involving rotation or orbit**. For instance, if a particle is attached to a string and whirls around, H_O about the center is constant if the string exerts no torque (meaning the string's force goes through the center). On the exam, you might be asked for angular momentum about a hinge or about the center of rotation, or to relate angular momentum before and after an event (like a lump of clay sticking to a rotating wheel – though that's more a rigid body scenario).

- **Choosing point O:** You are free to choose any reference point O to compute H_O, but a smart choice simplifies the problem. Often, choosing a point about which no external impulse is applied (like a frictionless pivot or the center of mass in absence of external forces) means H_O is conserved about that point. If a problem hints "no external torque about ___," think conservation of angular momentum.

Exam Handbook Search Cues (Not affiliated with or endorsed by NCEES): *angular momentum*, *moment of momentum*, *angular impulse*, *moment (torque)*, *conservation of angular momentum*.

Equation Passport: Angular Impulse–Momentum (Particle) – relates a moment applied over time to the change in a particle's angular momentum about a point.

Name and purpose: Angular Impulse–Momentum Principle (for a particle about point O) – determines how a torque (moment) acting over time changes the rotational momentum of a particle about that point. It answers questions like "How much will this spin/rotate or deviate due to a given impulse of force at a distance?" by equating moment impulses to angular momentum change.

Formulation (professional equation): $\sum_{t_1}^{t_2} M_O\ dt\ =\ H_{O2}\ -\ H_{O1}$, which in words states: the *angular impulse* about point O equals the change in *angular momentum* about O. Here $H_O = m\,(\mathbf{r} \times \mathbf{v})$ for a particle (a pseudovector pointing perpendicular to the plane, whose magnitude is $mvr_\perp$). If we choose counter-clockwise (CCW) as positive, for example, we must stick with that convention for M_O and H_O signs.

Variables and units:

- M_O – the net moment (torque) about point O acting on the particle (units: N·m in SI, or e.g. lbf·ft in US). This could be caused by a force acting at a distance; if multiple forces, sum their moments about O.
- t – time (s). The integration $\int M_O dt$ accumulates moment over the time interval.
- H_{O1}, H_{O2} – angular momentum about point O at the beginning and end of the interval (units: kg·m²/s in SI). For a particle of mass m, $H_O = m\,v\,r_\perp$, where $r_\perp$ is the perpendicular distance from O to the particle's velocity vector (effectively the lever arm of the momentum). In planar problems, you might also compute $H_O = m(xv_y - yv_x)$ if using coordinates (this is the z-component of $m\,\mathbf{r} \times \mathbf{v}$). Direction: By right-hand rule, H_O vector points out of or into the page; but in 2D we often just treat clockwise vs. counter-clockwise as positive/negative.
- $\sum_{t_1}^{t_2} M_O\ dt$ – **angular impulse** about O (units: N·m·s). This is the time-integrated moment. It could come from a single brief pulse of torque or continuous application of a twisting force.

Assumptions and scope:

- The mass of the particle remains constant (no mass distribution change for the particle itself; it's a point mass).
- The equation is applied about a fixed reference point O. That point can be anywhere, but it's often convenient to choose O as either a fixed pivot or the center of mass of a system. For a particle not attached to anything, you can choose any point; the relationship holds true, but remember if O is accelerating itself (non-inertial frame) things get complicated – on the FE exam, stick to an inertial reference or a fixed point.
- All external moments about that point are accounted for in M_O. If a force acts but passes directly through O, its moment about O is zero and thus doesn't contribute to angular impulse (hence won't change H_O about that point).

- Planar motion is assumed for simplicity (we consider rotation in a plane about a perpendicular axis). For a general 3D case, one would use vector form **H** and vector **M**, but FE Mechanical problems are usually planar.
- The formula also works for a **system of particles**: $\Delta\sum H_O = \int \sum M_O dt$. So you could sum angular momentum of multiple particles (or parts) and equate to net external moment impulse.

Limit tests (sanity checks):

- If $\int M_O dt = 0$ (no net angular impulse about O), then $H_{O2} = H_{O1}$ – angular momentum about O is conserved. This matches physical intuition: without any twist or torque, the rotational "content" about that point remains constant. For example, if a particle is moving in a straight line and you choose O along that line, H_O is zero initially and remains zero (no change, trivial case). If you choose O off the path and no forces act, the particle's H_O stays the same (it will keep orbiting O with constant moment arm and speed relative to that point).
- As the time interval $\Delta t \to 0$, the equation reduces to the instantaneous form $dH_O/dt = M_O$ (which is just Newton's second law for rotation for a particle) – a good check that the integral form is consistent with the differential form.
- If the particle moves directly toward or away from point O (so that $r_\perp = 0$ or v is along the line to O), its angular momentum about O is zero. Then the equation says $\int M_O dt = 0$ for any change – indeed if a particle moves radially in/out, only a radial force (no moment) is needed to change its speed, and no torque is required to alter H_O (since it has none).

Use vs. sibling equations: Use angular impulse–momentum when dealing with **rotation caused by forces** that act off-center. If you have a problem with a force creating a spin or a torque applied over time (e.g., a door being hit by a moving object, a pulley with a tension over some time, or a particle moving in a circular path under a central force), this is the tool. Contrast this with **linear impulse–momentum**: if you only care about straight-line motion through the center of mass, use linear. If rotation about a point is of interest, use angular. Also differentiate from **work-energy for rotation**: energy methods might give you angular velocity from work done by a torque, but impulse–momentum gives you the change in angular velocity from the torque-time history. Importantly, **use angular momentum conservation** (a special case of this principle) instead of kinematics when no external moment acts – for instance, spinning objects or particles that collide and stick together (you'd equate total angular momentum before and after).

Common exam traps:

- **Sign conventions (CW vs CCW):** It's easy to get the sign of H_O or M_O wrong. Decide which rotation direction is positive (usually counter-clockwise is taken as positive angular momentum/impulse by convention, but you can choose either as long as consistent). A torque that tends to rotate the particle in the positive direction should be taken positive. If you mix this up, you might erroneously think angular momentum isn't conserved or get a negative value where you expected positive. A quick way to check is to use the right-hand rule for $\mathbf{r} \times \mathbf{v}$: if H_O is out of page, call that positive (for CCW motion typically).
- **Using the wrong distance (r):** Remember r in the formula mvr is the perpendicular distance from point O to the line of motion of the particle (also known as the moment arm). Students sometimes plug in the straight-line distance between O and the particle, which is correct **only if** the velocity is perpendicular to that line. If the velocity is at an angle, you must use the component of r perpendicular to v (or component of v perpendicular to r). In problem-solving, if coordinates are given, compute $H_O = m(xv_y - yv_x)$ (essentially the 2D determinant formula).
- **Forgetting to include all forces in M_O:** If multiple forces act, ensure you sum their moments about the same point. For instance, if a gravitational force and a push both act, each could create a moment about O. If one of them passes through O, its moment is zero (don't include it in the sum). Missing a force's moment is like missing a force in linear momentum—your result will be off.
- **Mixing reference points incorrectly:** H_O and M_O must be defined about the **same point O**. Don't, for example, compute initial angular momentum about the center of mass and final about a hinge – the equation doesn't hold across different reference choices. Pick one point and stick to it for the entire impulse–momentum calculation.

Units: Ensure moment units and momentum units are consistent. N·m·s for angular impulse equals change in kg·m²/s. In US units, if you use lbf and feet, angular momentum might be in slug·ft²/s, etc. Just keep track (the exam usually sticks to SI, but be prepared).

Footnotes: Angular momentum is sometimes denoted L in textbooks, but the FE Handbook uses H for angular momentum of a particle or system about a point. Be comfortable with both notations. Also, the concept extends to rigid bodies (with $H = I\omega$ for a body's rotation about its center of mass, for example), but here we focus on a particle. For a rigid body in plane rotation, the angular impulse–momentum equation becomes $\int M dt = I\Delta\omega$ (analogous form), but that's typically in another subtopic.

Variations and related forms: For a single particle, $H_O = mr_\perp v$. If multiple particles are involved, total angular momentum is $H_{O,\text{total}} = \sum_i m_i\, v_i r_{\perp i}$ (about the same point). The conservation form is often used: $\sum H_{O,\text{initial}} = \sum H_{O,\text{final}}$ if $\sum\int M_O dt = 0$ (no external angular impulse). A **common special case** is motion about the center of mass: if you take moments about the center of mass of an isolated system, there are no external moments about that point, so the total angular momentum about the center of mass remains constant. Another variant: if dealing with rotation in terms of angular velocity for a rigid body or a point mass on a string, you might use $H = I\omega$ (where I is mass moment of inertia about O) for convenience, but then ensure to use I for the point mass ($I = mr^2$ for a point mass at distance r from O). The impulse–momentum equation then looks like $\int M_O dt = I_O(\omega_2 - \omega_1)$, which is the rotational analog (I for a point mass is just mr^2, so it reduces back to $mr^2\Delta\omega$ which indeed equals $mr(r\Delta\omega) = mr\Delta v_\perp = mv\Delta r_\perp$ in appropriate terms).

Special notes (calculator): If calculating $H_O = m(xv_y - yv_x)$, be careful with inputting the numbers in your calculator – it's easy to swap or drop a sign. It might be safer to calculate H_O in two steps: compute mxv_y and myv_x separately then subtract. Also, if you

need to find $r_\perp$ given an angle, you can do $r_\perp = r\sin\theta$ (where θ is the angle between **r** and **v**). Ensure your calculator is in the correct mode (degrees vs radians) if you use trigonometric functions for this.

Explanation: The angular impulse–momentum principle for particles is conceptually similar to the linear case: it tells us how a twist or off-center push changes the rotational aspect of motion. Picture a particle moving in a straight line past some point O. It has some angular momentum about O by virtue of its motion and distance. If no force tries to rotate it around O (no lateral push), it will keep going and maintain that H_O. But if you apply a sideways force (creating a moment about O) – say you nudge a moving puck so that it starts circling around – you've applied an angular impulse and changed H_O. On exam day, you'll use this when a problem involves **torques over time** or asks for **rotational effects of linear motion**. For example, a question might give: "A 2-kg object moving at 3 m/s passes 4 m from point O. A 5 N force acts on it perpendicular to its direction for 2 seconds. What is its angular momentum about O after the force?" You'd compute initial $H_O = 234 = 24$ kg·m^2/s, then angular impulse $= 5 *$ 4 m (moment arm) $*$ 2 s $= 40$ N·m·s (taking care with the 4 m lever arm if the 5 N force is perpendicular at 4 m). Add that (vectorially) to the initial H_O to get final $H_O = 64$ kg·m^2/s about O. It's often that straightforward: find initial angular momentum, add the torque impulse.

Analysis: Term by term in $\int M_O dt = H_{O2} - H_{O1}$:

- $\int M_O dt$ is the **angular impulse**. It is the accumulated twist applied to the system. If M_O is constant, this is just $M_O \Delta t$. If M_O varies (e.g., a time-varying torque), the integral sums all those little contributions. Physically, it's how much angular momentum you "delivered" to the particle.

- H_{O1} and H_{O2} are the **angular momentum** at the start and end. $H = mvr_\perp$ can be visualized: mv is linear momentum and $r_\perp$ is the lever arm – multiply to get a moment of momentum. If the particle is moving CCW around O, H is positive (say); if CW, H is negative with that sign convention.

- The difference $H_{O2} - H_{O1}$ is the **change in angular momentum**. The equation is basically saying *change in angular momentum = angular impulse*. This mirrors the linear case. It tells us that if you want to change how much "rotation" a particle has about O, you must apply a moment over time. Without it, H stays the same.

- Keep track of the **axis or point** about which you're calculating things. The angular momentum is always defined with respect to O, and the moment too. If the problem shifts the reference point mid-way, you cannot directly use the impulse–momentum equation across that change. One trick: sometimes a problem might implicitly use angular momentum about center of mass vs about a pivot; in those cases, use appropriate parallel axis considerations if needed (which is more for rigid bodies – probably not needed for a simple particle).

- **Units sanity:** N·m·s = kg·m²/s, check. In a calculation, if you compute mvr and get 24 kg·m²/s, and an impulse of 40 N·m·s, they can be added because they're the same unit dimension. If you accidentally forgot to multiply by mass or distance in computing H, units won't match and that flags an error.

- **Check extreme cases:** If the force acts right through point O (so $r_\perp = 0$ for that force), then it produces no angular impulse (because $M_O = 0$), and indeed it won't change H_O. If the particle moves straight past O at a huge distance, a small perpendicular nudge (small M_O) might barely change its path – H_O won't change much. If the particle comes very close to O (small r) but you give a tiny perpendicular push at the right time, it can drastically alter H_O relative to O (because the same absolute change in path at a small radius is a big relative rotation effect). This is analogous to torque effects in lever: a small force at a big lever = big effect; a big force at zero lever = no rotational effect.

- Finally, connect this to **conservation**: if no net M_O, then H_O is constant. That means you can equate initial and final $mvr_\perp$. Problems might present this as, say, a satellite moving closer to Earth (decreasing r, so its speed must increase to keep mvr constant if no external torque acts). In particle terms, if a particle is moving and suddenly no force acts (free motion), H_O about any fixed point remains fixed. This is often a quicker way to solve certain geometry-of-motion questions than going into forces and accelerations.

K07.T05.S03 – Impact and Collision Analysis (Elastic & Inelastic Collisions)

Principle at a Glance: In collisions (impacts between bodies), the governing principle is conservation of momentum along the line of impact **in the absence of external impulses**. This means that if two bodies collide and no external force acts on them during that very short collision time, their **total momentum is the same just before and just after impact**. However, mechanical energy (kinetic energy) may or may not be conserved, depending on the elasticity of the collision:

- **Elastic collision:** No kinetic energy is lost. Both momentum *and* kinetic energy are conserved. This ideal case corresponds to a **coefficient of restitution** $e = 1$ (maximum bounciness).

- **Perfectly inelastic (plastic) collision:** The objects stick together after collision, moving as one mass. In this case kinetic energy is maximally lost (objects deform and generate heat, etc.), and the coefficient of restitution $e = 0$ (no bounce at all). Momentum is still conserved, but you cannot equate kinetic energy before and after.

- **General inelastic collision:** Some energy is lost, but the objects do not necessarily stick. $0 < e < 1$. Momentum is conserved regardless of e, but kinetic energy drops by a factor depending on e. The coefficient of restitution (a number between 0 and 1) quantifies the restitution or "bounce" in the collision.

- **Coefficient of restitution (e)** – This is a key parameter for collisions. By definition, e is the ratio of relative speed of separation to relative speed of approach, along the line of impact. In one dimension (direct head-on impact), $e = \frac{v_{2f} - v_{1f}}{v_{1i} - v_{2i}}$, where v_{1i}, v_{2i} are the initial velocities of bodies 1 and 2 (before collision) and v_{1f}, v_{2f} are their final velocities (after collision). Here we assume object 1 is approaching object 2, so $v_{1i} > v_{2i}$, making the denominator positive. The numerator $v_{2f} - v_{1f}$ then represents how fast object 2 moves away from object 1 after collision. This expression is algebraically equivalent to the standard definition of restitution. The value of e is between 0 and 1: - $e = 1$: **Perfectly elastic.** The objects bounce off with no kinetic energy loss (e.g., ideal billiard balls, ideally elastic spheres). - $e = 0$: **Perfectly inelastic.** The objects stick together or move with the same velocity after impact (maximum energy loss, but momentum still conserved). - Intermediate $0 < e < 1$: Partially elastic. Some rebound occurs, but some energy is dissipated (real-world

collisions, like a car crash where they don't stick together but deform and lose energy).

- **Momentum conservation:** For any collision with no external forces in the direction of collision, **linear momentum is conserved** in that direction. In equation form (one-dimensional, along the line of impact): $m_1 v_{1i} + m_2 v_{2i} = m_1 v_{1f} + m_2 v_{2f}$, where m_1, m_2 are the masses and v are velocities (with sign indicating direction along the line). This holds true regardless of the elasticity of the collision. It's basically the impulse–momentum principle with $\int F dt = 0$ for the net external force, so initial momentum = final momentum.

- **Two equations, two unknowns:** Typically, collision problems give you initial velocities and either the coefficient of restitution or a description of the collision type (elastic/inelastic). To find the two unknown final velocities, you use: 1. Conservation of momentum. 2. The restitution relationship (or energy conservation if elastic). These two equations can be solved simultaneously for v_{1f} and v_{2f}. For perfectly inelastic cases, instead of restitution, you know $v_{1f} = v_{2f}$ (they move together), which also provides the second equation.

- **Energy consideration:** You might be asked to compute energy lost in a collision. To do that, find initial kinetic energy $\frac{1}{2}m_1 v_{1i}^2 + \frac{1}{2}m_2 v_{2i}^2$ and final kinetic energy $\frac{1}{2}m_1 v_{1f}^2 + \frac{1}{2}m_2 v_{2f}^2$, then subtract. In an elastic collision, the loss will be zero (energies equal). In an inelastic collision, the loss is positive. Often using e is easier than directly using energy, but for $e = 1$ you can directly equate energies as well.

Exam Handbook Search Cues (Not affiliated with or endorsed by NCEES): *impact*, *collision*, *coefficient of restitution*, *elastic collision*, *inelastic*, *momentum conservation*.

Definition Passport: Coefficient of Restitution (e)

- **Plain-language definition:** The **coefficient of restitution**, e, is a dimensionless number that measures how bouncy a collision is. It's the ratio of how fast objects separate after a collision to how fast they were coming together before the collision.

- **Where it matters (exam impact):** You'll use e in any collision/impact problem to relate velocities after the collision to those before. On the FE exam, if a problem gives you e or mentions "elastic" or "inelastic," it's a cue to apply the restitution formula along with momentum conservation. For instance, to determine post-collision speeds or to find how much kinetic energy is lost, you need e. If $e = 1$, you know energy is conserved; if $e = 0$, they stick together; if some value in between, you plug into the formula above.

- **Pitfall or confusion point:** A common mistake is getting the order wrong in the e formula or sign errors. Remember, it's relative *speed* (magnitude) along the line of impact: $e = \frac{\text{speed of separation}}{\text{speed of approach}}$. To avoid sign confusion, many use the convention of subtracting velocities in a specific order as given by the formula. Essentially, take the difference in velocities after (second minus first, assuming first was originally faster) and divide by the difference in velocities before (first minus second). Also, note that e is about the velocity *component along the line of impact* (normal to the contact surface). Components perpendicular to the impact (tangential direction) are unaffected by e (they remain the same before and after if no friction).

- **Micro-check:** True or False? – *If two objects have a coefficient of restitution $e = 0.5$, it means that half of the kinetic energy is conserved in the collision.*
Answer: False. Coefficient of restitution being 0.5 does **not** directly mean half the kinetic energy remains – it means the separation speed is half the approach speed. The fraction of kinetic energy conserved is generally different from e (for example, with $e = 0.5$, only 25% of kinetic energy might remain if masses are equal; energy loss depends on both e and the mass ratio).

Equation Passport: Collision Equations – Key equations for two-body collisions in one dimension (along line of impact):

- **Momentum Conservation:** $m_1 v_{1i} + m_2 v_{2i} = m_1 v_{1f} + m_2 v_{2f}$
  Purpose: Ensures total momentum remains the same before and after collision (no external impulse). Use this equation always for collision problems.
- **Coefficient of Restitution:** $e = \frac{v_{2f} - v_{1f}}{v_{1i} - v_{2i}}$
  Purpose: Relates the relative velocities. It provides the second equation needed to solve for unknown final velocities. If not given explicitly, infer e from context: elastic ($e = 1$), perfectly inelastic ($e = 0$), or some intermediate restitution given.
- **Alternate forms:** For perfectly inelastic cases, $v_{1f} = v_{2f}$ (the masses stick and move together). For elastic cases ($e = 1$), you could replace the restitution equation with kinetic energy conservation: $1/2\, m_1 v_{1i}^2 + 1/2\, m_2 v_{2i}^2 = 1/2\, m_1 v_{1f}^2 + 1/2\, m_2 v_{2f}^2$ (although using $e = 1$ in the simpler formula above is usually easier and less error-prone on an exam).

Variables and units:

- m_1, m_2 – masses of object 1 and 2 (kg or slugs).
- v_{1i}, v_{2i} – initial velocities of object 1 and 2, along the line of impact (m/s or ft/s). Make sure to assign a positive direction (e.g., toward the right or object 2's initial direction) and stick to it. If one object is moving opposite to your positive direction, its velocity will be negative in these formulas.
- v_{1f}, v_{2f} – final velocities after collision (same units, along the same line, sign-convention consistent).
- e – coefficient of restitution (no units, $0 \le e \le 1$).

Assumptions and scope:

- Collision is **instantaneous** (impulse occurs over a very short time) and **isolated** (external forces during that instant, like friction with ground or air resistance, are negligible compared to the collision forces). This justifies momentum conservation during impact.
- Motion is along a single line (one-dimensional impact). For oblique impacts, you would apply these equations along the line of impact (normal direction) and separately note that perpendicular components of velocity remain unchanged (if surfaces are smooth). The FE exam usually keeps to either head-on or simple plane collisions without complicating friction during impact.
- Bodies are approximated as particles (or you consider only translational motion). If rotation is involved (e.g., a ball spinning when it hits a surface), then additional considerations are needed (and those are more advanced than typical FE questions unless specifically hinted).

- Coefficient of restitution is an empirical constant for the pair of materials in collision. It may be given, or you infer it from the type of collision.

Limit tests (sanity checks):

- If $e = 1$ (perfectly elastic), the relative speed after equals relative speed before. If two equal masses collide elastically (like Newton's cradle balls), they essentially exchange velocities. A sanity check: if $m_1 = m_2$ and $e = 1$, the formulas predict $v_{1f} = v_{2i}$ and $v_{2f} = v_{1i}$ – which matches the intuitive outcome (first mass stops, second takes off with initial speed of first).
- If $e = 0$ and the masses stick, momentum conservation gives a common final velocity $v = \frac{m_1 v_{1i} + m_2 v_{2i}}{m_1 + m_2}$. If one mass was zero velocity initially, the final velocity will be an average weighted by mass (the heavier object pulls the speed more towards its initial value). Check extreme: if $m_1 \gg m_2$ and m_2 was at rest, the combined velocity will be only slightly less than v_{1i} (massive object barely slows, small object clings on). If $m_2 \gg m_1$ instead, the final velocity is close to v_{2i} (the small object just sticks and almost adopts the large object's original velocity). These make sense physically.
- Momentum conservation should always hold. If you calculate final velocities and plug back into $m_1 v_{1f} + m_2 v_{2f}$ and it doesn't equal the initial total momentum, something went wrong in algebra or sign.
- e boundaries: e cannot be negative or greater than 1 for real collisions. If you ever solve and get, say, $e = 1.2$ or $e = -0.3$, that indicates an error (or that energy was added or weirdly defined scenario – not typical in exam).

Use vs. alternative approaches: Use these collision equations whenever dealing with impacts. Compared to a work-energy approach, momentum and restitution are more straightforward for collisions because energy is not conserved generally. Work-energy could be used for elastic collisions but offers no help in inelastic ones beyond computing energy loss. Using impulse–momentum (which these equations essentially are derived from) is the standard method. Remember, **momentum is conserved in all collisions (isolated), energy only in elastic ones**. Also, if one object is significantly more massive than the other (like a ball hitting Earth), sometimes it's easier to switch to the frame of the heavy object or realize one velocity is almost unchanged – but that's more of an intuitive check. Stick to formulas when in doubt.

Common exam traps:

- **Direction and sign mistakes:** This is number one. If object 1 is moving right and object 2 left towards it, you must assign a direction as positive (say rightward). If you set right as positive, then object 2's initial velocity is negative in the equations. Many mistakes come from forgetting to include that negative, leading to using a wrong relative speed or messing up momentum signs. Write down clearly: "Let rightward be +. Then $v_{1i} = \ldots$, $v_{2i} = \ldots$ (might be negative)." Do the same after collision if, say, one reverses direction (it will show up as a negative final velocity if it goes leftward).
- **Mixing up which velocity goes where in the e formula:** The formula $v_{2f} - v_{1f}$ over $v_{1i} - v_{2i}$ might seem arbitrary. It assumes object 1 and 2 labeling such that 1 was approaching 2. A safer conceptual way: $e = \frac{\text{(speed after collision along line) relative}}{\text{(speed before collision) relative}}$. In practice, you can compute $|v_{1f} - v_{2f}|/|v_{1i} - v_{2i}|$ as long as you interpret correctly who is separating from whom. But be cautious: the subtraction order in the official formula implicitly takes care of direction. Stick to that order if you label object 1 as the one that was initially moving faster toward the other.
- **Forgetting that e only applies to the line-of-impact component:** If a collision isn't head-on (say a glancing blow), break velocities into normal (along impact line) and tangential (perpendicular) components. Apply momentum conservation and restitution to the normal components only. Tangential components remain the same before and after (no impulse in that direction if surfaces are frictionless). Some students erroneously try to use e on the total speeds or mix components, which is wrong. The exam may not delve deeply into oblique collisions, but understanding this prevents misusing formulas.
- **Plugging restitution incorrectly for perfectly inelastic case:** In a perfectly inelastic collision, $e = 0$, so the restitution equation gives $0 = (v_{2f} - v_{1f})/(v_{1i} - v_{2i})$. This just means $v_{2f} - v_{1f} = 0$, i.e. $v_{2f} = v_{1f}$, which we already know (they stick together). Some might get confused and think it implies initial velocities are zero or something else – just remember $e = 0$ means final velocities are equal. It's often easier to jump straight to using the single combined mass for momentum: $m_1 v_{1i} + m_2 v_{2i} = (m_1 + m_2) v_{\text{final}}$.
- **Energy calculations:** If asked for energy loss, compute initial and final kinetic energies. A trap can be forgetting to convert units (if masses in slugs and velocities in ft/s, energy will come out in ft·lb$_f$ which is okay if consistent). Another is using e incorrectly to get energy – remember e is not a direct measure of energy retained, the fraction of energy retained is something like e^2 when masses are equal (derivation beyond scope here).
- **Footnotes:** The coefficient of restitution formula given is for a *central impact* (bodies moving along the line of centers). If the collision is non-collinear (oblique), you decompose along the line of impact. Also, real materials have characteristic restitution typically less than 1 (e.g., steel on steel might be around 0.9 for a bounce, rubber on concrete ~0.6, etc., though exam usually just provides a value). And remember, momentum being a vector means if a collision problem is two-dimensional, you conserve momentum in both x and y directions separately, but apply restitution in the direction of impact only. That can yield some interesting results (like a ball hitting a wall: horizontal momentum changes (with e), vertical momentum (if no gravity impulse during collision) is conserved). Keep the contexts clear in multi-dimensional cases.

Variations and related forms: You might encounter formulas for final velocities solved explicitly in terms of initial velocities and e. For example, for a 1D two-body collision the solved equations are:

- $v_{1f} = \frac{m_1 - e\, m_2}{m_1 + m_2} v_{1i} + \frac{m_2(1+e)}{m_1 + m_2} v_{2i}$,
- $v_{2f} = \frac{m_1(1+e)}{m_1 + m_2} v_{1i} + \frac{m_2 - e\, m_1}{m_1 + m_2} v_{2i}$.

These look daunting, but they are just the result of solving the two equations for v_{1f} and v_{2f}. You are **not required to memorize** these forms for the FE Exam – it's safer to derive on the spot using momentum and restitution if needed. However, noticing special cases can save time: - If $m_2 \gg m_1$ (object 2 much heavier, like a ball hitting Earth), then $v_{2f} \approx v_{2i}$ (the heavy object's velocity is essentially unchanged) and $v_{1f} \approx -e\,(v_{1i} - v_{2i}) + v_{2i}$, which for $v_{2i} = 0$ simplifies to $v_{1f} \approx -e\,v_{1i}$. This is the case of a small object bouncing off a huge object: e.g., a ball dropping on the ground (ground doesn't move, ball rebounds with $v_{\text{up}} = e v_{\text{down}}$). - If $m_1 = m_2$, the formulas simplify a lot: $v_{1f} = \frac{1-e}{2} v_{1i} + \frac{1+e}{2} v_{2i}$ and $v_{2f} = \frac{1+e}{2} v_{1i} + \frac{1-e}{2} v_{2i}$. For elastic $e = 1$, this becomes $v_{1f} = v_{2i}$ and $v_{2f} = v_{1i}$ (swapping speeds as mentioned). For perfectly inelastic $e = 0$, it gives $v_{1f} = v_{2f} = \frac{v_{1i}+v_{2i}}{2}$ (common average velocity). - If one object is initially stationary ($v_{2i} = 0$), sometimes it's easier to remember: $v_{1f} = \frac{m_1 - e m_2}{m_1 + m_2} v_{1i}$ and $v_{2f} = \frac{2m_1}{m_1+m_2} \frac{1+e}{2} v_{1i}$ (the second simplifies to $\frac{m_1(1+e)}{m_1+m_2} v_{1i}$ as above). But rather than memorize, derive it quickly: use momentum to express one final velocity in terms of the other and plug into restitution.

In **glancing collisions**, break the velocities into components normal and tangential to the impact surface. Use e on the normal components as above, and know that tangential components remain the same (if no friction). For example, if a ball hits a wall at an angle, its velocity perpendicular to the wall reverses direction and is reduced by factor e, while the parallel component stays the same.

Special notes (calculator and strategy): Solving collisions is algebra-heavy but manageable. When using the calculator, be mindful of parentheses and order of operations when solving two equations. A strategic approach: solve the momentum equation for one of the final velocities (say $v_{1f} = \frac{m_1 v_{1i} + m_2 v_{2i} - m_2 v_{2f}}{m_1}$) and substitute into the restitution equation. It's easy to make algebra mistakes, so double-check by plugging your solution back into both original equations if time permits. Also, keep an eye on whether the question asks for speed (magnitude) or velocity (which could require a direction or sign). For perfectly inelastic collisions, skip using $e = 0$ in the formula and directly combine masses for momentum – it's quicker and less error-prone. And finally, if you're ever unsure about your results, test extreme cases (like those we discussed) as a gut check, or verify dimensions: the results should have units of velocity and make physical sense (no faster separation than approach if $e < 1$, etc.).

Explanation: Collision analysis on the FE exam boils down to applying momentum conservation and the coefficient of restitution appropriately. Imagine two carts on a frictionless track: cart A (2 kg) moving at 5 m/s hits cart B (3 kg) at 0 m/s. Momentum says $25 = 2v_{Af} + 3v_{Bf}$. *Without more info, infinite solutions exist (they could stick or bounce in many ways). The coefficient of restitution fills in the gap: if they stick ($e = 0$), then 52* = 5 * final velocity of combined 5 kg, giving final velocity 2 m/s for both. If $e = 1$ (elastic), using restitution and momentum you'd find the final velocities perhaps 1 m/s and 4 m/s (just as an example outcome) that also conserve energy. The point is, you systematically set up the equations and solve. One important insight: momentum being conserved is a vector equation, but in 1D we just pay attention to sign. If an object rebounds opposite to original direction, your solution for its v_f will naturally come out negative if you set the original direction as positive. Embrace that rather than trying to guess outcomes – the math will handle it if set up correctly.

In practical terms, when you encounter an impact problem:

1. **Define coordinate direction** (usually direction of approach as positive).

2. **Write momentum conservation**: $m_1 v_{1i} + m_2 v_{2i} = m_1 v_{1f} + m_2 v_{2f}$. (Be careful with signs of velocities based on your axis).

3. **Write restitution equation** or appropriate second condition: If e is given or can be inferred, write $v_{2f} - v_{1f} = e\,(v_{1i} - v_{2i})$. If perfectly inelastic, instead write $v_{1f} = v_{2f}$. If elastic and you forget restitution, you could write energy conservation $\frac{1}{2} m_1 v_{1i}^2 + \frac{1}{2} m_2 v_{2i}^2 = \frac{1}{2} m_1 v_{1f}^2 + \frac{1}{2} m_2 v_{2f}^2$ (but using $e = 1$ is simpler).

4. Solve the equations for the unknown final velocities. It might involve a bit of algebra – keep terms organized. It often helps to solve one equation for one variable and substitute into the other.

5. Once you have v_{1f}, v_{2f}, interpret the results physically. If you get a negative velocity for one object, that just means it reversed direction relative to your initial positive axis – which can happen in collisions (one object bouncing back).

6. You can then answer any follow-up like calculating kinetic energy loss: simply compute initial KE vs final KE. If $e < 1$, expect a loss. If $e = 1$, they should be equal (within rounding). 7. If it's a multi-dimensional collision (less common in FE), do step 2 and 3 for the line-of-impact component and remember perpendicular components: e.g., "The post-collision velocity component parallel to the surface remains the same as pre-collision if no friction."

Analysis: Let's analyze a specific case as it solidifies understanding. Say 1 kg ball moving at 10 m/s to the right hits a 3 kg ball at rest ($e = 0.8$ given).

- **Momentum before:** $110 + 30 = 10$ kg·m/s. After collision, momentum must still sum to 10.

- **Restitution:** $0.8 = \frac{v_{2f} - v_{1f}}{10-0}$, so $v_{2f} - v_{1f} = 8$ m/s (with right as positive). - **Solve:** From momentum: $1v_{1f} + 3v_{2f} = 10$. Solve with $v_{2f} = v_{1f} + 8$ (from restitution). Substitute: $v_{1f} + 3(v_{1f} + 8) = 10 \Rightarrow v_{1f} + 3v_{1f} + 24 = 10 \Rightarrow 4v_{1f} = -14 \Rightarrow v_{1f} = -3.5$ m/s. Negative means after collision, ball 1 is going left at 3.5 m/s (it bounced back). Then $v_{2f} = v_{1f} + 8 = 4.5$ m/s to the right. Check: momentum after = $1(-3.5) + 34.5 = -3.5 + 13.5 = 10$ ✓, matches initial 10. Relative speeds: approach speed = 10, separation speed = $4.5 - (-3.5) = 8$, ratio 8/10 = 0.8 ✓, matches e. Kinetic energy check (just for interest): initial KE = 50 J, final KE = $0.51(3.5^2) + 0.53(4.5^2) = 6.125 + 30.375 = 36.5$ J. Some energy (13.5 J) is lost, which is expected since $e = 0.8$ (not fully elastic). - By dissecting this example: ball 1 lost some speed and reversed direction, ball 2 gained speed. The algebra we did is exactly what you'd do on the exam, perhaps with simpler numbers. The key to avoiding error was careful sign assignment and using the two core equations systematically.

- **Extreme outcomes:** If $e = 1$, ball 1 would bounce back a bit less (in fact if masses differ, it wouldn't necessarily reverse if it's lighter; if it's heavier, it might plow through). If $e = 0$, they'd stick and go off together at 2.5 m/s (using combined mass momentum calc). It's good to think about these limits to ensure your solution falls in a reasonable range. - Finally, always interpret e: an e closer to 1 means a "bouncier" collision – less energy loss, objects

rebound strongly. An e near 0 means a "sticky" or plastic collision – lots of energy loss, objects don't separate much. In our example $e = 0.8$, it was pretty bouncy, and indeed ball 1 bounced back fairly fast (only lost 3.5 out of 10 m/s in speed, reflecting less energy lost). If e were 0.2, we'd expect ball 1 to almost stick and just move along with ball 2 slowly.

By mastering momentum and restitution, you will handle any collision problem the FE Mechanical Exam throws at you. Momentum methods are reliable and quick, making those impact questions much less intimidating on exam day.

Topic 06 - Kinematics of Rigid Bodies

Topic Scope & Importance: Kinematics of rigid bodies deals with how objects move when they rotate and translate without deforming. On the **FE Mechanical Exam**, this topic shows up in questions about rotating machinery parts, linkages, wheels, or any rigid component moving in a plane. The focus is on **angular motion** (how to describe rotation with angles, angular velocity, and angular acceleration) and **relative motion** between points on a rigid body. You'll typically face questions asking for speeds or accelerations of a point on a moving body, finding an instantaneous center of rotation, or computing a mass moment of inertia for rotating objects. Mastering this topic means you can quickly recognize when a rigid body's motion is pure rotation, pure translation, or a mix – and apply the right formulas to get the answer confidently on exam day.

K07.T06.S01 – Pure Rotation about a Fixed Axis (Angular Kinematics)

Principle Introduction – Subtopic at a Glance:

- **Pure Rotation** means every point in the rigid body moves in a circle about some fixed axis. Think of a door rotating about its hinge – the hinge is the fixed axis, and points on the door sweep circular arcs.

- Key descriptors are **angular displacement (θ)**, **angular velocity (ω)**, and **angular acceleration (α)**. These describe how far, how fast, and how quickly speeding up/slowing down the rotation is, analogously to linear motion's distance, velocity, and acceleration.

- These quantities are interrelated by calculus: angular velocity is the **change in angular displacement per unit time**, and angular acceleration is the **change in angular velocity per unit time**. In formula form: *ω is the derivative of θ*, and *α is the derivative of ω*.

- **Exam context:** This subtopic provides the foundational formulas for rotational motion. Typical questions might give you two of the three (θ, ω, α) or time and ask for the third, often assuming constant angular acceleration. It's analogous to linear kinematics problems, but for rotation.

- If rotation speed is **constant (α = 0)**, the motion is uniform and θ changes linearly with time. If there is **angular acceleration**, you may need to use kinematics equations (similar to SUVAT equations from physics, but for angles).

Exam Handbook Search Cues (Not affiliated with or endorsed by NCEES): *angular velocity*, *rad/s*, *rotation*, *constant angular acceleration* (These are keywords to quickly find rotational motion formulas in the exam handbook's dynamics section.)

Footnotes:

- *Units:* Always use **radians** when applying calculus-based formulas for θ, ω, α. [^1] Degrees must be converted to rad (1 rev = 2π rad) for use in ω = dθ/dt, etc.

- *Symbol convention:* ω (omega) is typically used for angular velocity; don't confuse it with *w* (which might denote weight or work elsewhere). α (alpha) is angular acceleration; a plain *a* usually means linear acceleration. θ (theta) is an angle (angular position).

- *Scope:* We assume a **fixed axis** – meaning the axis of rotation doesn't move. No translation occurs, so the center of rotation stays put. Equations simplify because every point's motion is purely circular around that axis.

Variations and Related Forms:

- **Constant Angular Acceleration Equations:** If α is constant (common exam assumption unless stated otherwise), you can use equations similar to linear motion:

- $\omega = \omega_0 + \alpha \cdot t$ (angular velocity after time *t*)
- $\theta = \theta_0 + \omega_0 \cdot t + \frac{1}{2} \alpha \cdot t^2$ (angular displacement after time *t*)
- $\omega^2 = \omega_0^2 + 2\alpha (\theta - \theta_0)$ (relates angles and angular speeds)

These mirror the s, v, a equations for constant linear acceleration. They are the standard constant-α rotational kinematics relations (analogous to constant linear acceleration), and you can derive or recall them by analogy.

- **Special cases:** If angular acceleration α = 0, then ω is constant (rotation at constant speed) and θ increases linearly ($\theta = \theta_0 + \omega \cdot t$). If initial angular velocity $\omega_0 = 0$ (starting from rest), then $\omega = \alpha \cdot t$ and $\theta = \frac{1}{2} \alpha \cdot t^2$. These limit cases are good sanity checks.

- **Typical angular speeds:** For perspective, 1 rad/s is about 9.55 rpm. Rotational speeds on exam might be given in rpm (convert to rad/s). A motor spinning at 1800 rpm has ω ≈ 188.5 rad/s. You should be comfortable converting between rev/min and rad/s quickly.

Special Notes (Calculator Tips): Ensure your calculator is in **radian mode** when plugging into rotational kinematics formulas. If you prefer, convert degrees to radians manually. For example, to input 45°/s as an angular velocity, convert 45° to 0.7854 rad (since 45° = π/4 rad). The Casio fx-115/991 and TI-36X Pro allow quick deg↔rad conversions (look for a DRG or unit conversion key). Always include π in calculations rather than approximating it too early for better precision on exam problems.

Equation Passport: Angular Motion Definitions – Relates angular displacement, angular velocity, and angular acceleration for rotation about a fixed axis.

Name & Purpose: Angular Kinematic Relations – These equations define how angular position, speed, and acceleration are related in time for pure rotation. They let you compute one if you know the others (for instance, find ω at a given time if you know α).

Equation: $\omega = \frac{d\theta}{dt}, \alpha = \frac{d\omega}{dt}$

Variables:

- θ = angular displacement (radians) – the angle turned from a reference position.

- ω = angular velocity (rad/s) – how fast the angle is changing at that instant (positive for counterclockwise [^2], by convention).
- α = angular acceleration (rad/s²) – how fast the angular velocity is changing (positive when speeding up counterclockwise rotation).
- t = time (s).

Assumptions:

- These definitions assume θ is measured in *radians* (so that the derivatives make sense numerically [^1]).
- The motion is about a fixed axis, so ω and α are along that axis (usually we treat counterclockwise rotation as positive in planar problems).
- We are dealing with a rigid body or object rotating as a whole, not a deformable shape – so every point shares the same ω and α at a given time (though their individual linear speeds differ by radius).
- Valid for instantaneous values even if α is not constant. (If α is not constant, integrate α(t) to get ω(t), and ω(t) to get θ(t).)

Limit Checks (sanity tests):

- If $\alpha \rightarrow 0$, then $d\omega/dt = 0$ which implies ω is constant. The equations correctly reduce to uniform rotation (no acceleration).
- If $\omega \rightarrow 0$, that means $d\theta/dt = 0$ – the rotation stops (θ becomes constant). For example, if you momentarily have zero angular velocity, the object is instantaneously at rest rotationally.
- Dimensional check: $d\theta/dt$ has units of rad/s (since θ in rad, t in s) which is a valid unit for ω. Likewise $d\omega/dt$ gives rad/s² for α. If you accidentally left θ in degrees, $d\theta/dt$ would come out in degrees/s which is inconsistent unless converted. Always ensure radian measure in differentiation.

Use vs. Sibling Equations: Use these angular definitions **instead of linear motion formulas** when dealing with rotation. They are the rotational analog of $v = ds/dt$ and $a = dv/dt$ for linear motion. Also, use these in place of any averaged angular speed formulas when precision is needed – e.g., avoid using $\omega_{avg} = \Delta\theta/\Delta t$ for non-uniform rotation except as an approximation; the calculus form is exact.

Common Exam Traps:

- **Degree-Radian mix-up:** Plugging an angle in degrees into $\omega = d\theta/dt$ calculations. This will yield an ω off by a factor of $\pi/180$. Always convert degrees to radians [^1].
- **Sign convention errors:** Forgetting that clockwise vs. counterclockwise was defined a certain way in the problem. If you assume the wrong positive direction, your α might come out negative of the expected. Clearly define a positive rotation direction (usually CCW) at the start.

Using constant-α formulas when α isn't constant: The three kinematic equations given ($\omega = \omega_0 + \alpha t$, etc.) assume α is constant. If a problem hints that α varies with time, don't blindly apply those – you might need to integrate. The exam may include a simple functional form like α = k (constant) or α = f(θ), etc., but typically it sticks to constant acceleration scenarios for kinematics.

Mixing up linear and angular quantities: Remember that $v = \omega r$ relates linear speed of a point at radius *r* to ω. But v and ω are different types of quantities. An exam question might give you a linear speed of a rotating object's point and ask for ω (or vice versa). Use $v = \omega r$ (for tangential speed) correctly and don't equate linear and angular values directly.

Explanation & Analysis: In pure rotation, every point on the rigid body moves in a circle around the fixed axis. The **basic idea** is that we can describe the entire motion by how the **angle θ** changes with time. Angular velocity ω tells us "how many radians per second" the object is rotating at a given instant, and angular acceleration α tells us how ω is changing (speeding up or slowing down the spin). These concepts are crucial in problems like finding how fast a wheel needs to spin to achieve a certain linear tip speed, or how long it takes for a rotating fan to speed up to full rate under constant angular acceleration.

To break it down term by term: $\omega = d\theta/dt$ means that if you graph angular position vs. time, the slope of that graph at any point is the angular velocity. For example, if θ = 2t² (a function of time), then $\omega = d(2t^2)/dt = 4t$, which tells us the angular velocity increases linearly with time. In SI units, θ is measured in radians (which are technically dimensionless, but we attach "rad" to remind us it's an angle), so ω comes out in rad/s. If ω = 2 rad/s, that means in one second, the object rotates through 2 radians (~114.6°). Similarly, $\alpha = d\omega/dt$ indicates how ω changes; e.g., if ω increases by 5 rad/s over 1 second, α = 5 rad/s².

A common **pitfall** is mixing up angular and linear measures: remember that a point on the rotating body has a linear velocity v related to ω by $v = \omega r$ (tangential component). So if you're asked for, say, the speed of a turbine blade tip, you find ω first (using rotational kinematics or given data) and then multiply by the blade length *r*. Another pitfall is forgetting centripetal acceleration: any point on the rotating body also has an inward acceleration $a_n = \omega^2 r$ (pointing toward the rotation center) even if ω is constant. Though centripetal acceleration isn't explicitly in this subtopic's list, it's part of understanding rotation – if the exam question asks for total acceleration of a point on a spinning object, you'd have to combine tangential $a_t = \alpha r$ (zero if α=0) and normal $a_n = \omega^2 r$. Keep these in mind when analyzing motion, even if the immediate question is about angular quantities.

In summary, pure rotation kinematics is all about tracking angles and angular speed. It matters on the exam because many mechanical components rotate (gears, wheels, shafts). Knowing how to go from "it spins at X rpm" to "point on it has Y m/s velocity and Z m/s² acceleration" is a fundamental skill. With the angular kinematic relations in your toolbox, you can confidently handle any problem where something is twisting or turning with a fixed center. Just remember to be consistent with units and sign directions, and you'll avoid the most common mistakes.

K07.T06.S02 – Instantaneous Center of Zero Velocity (Planar Motion)

Principle Introduction – Subtopic at a Glance:

- A **rigid body in general planar motion** (combination of translation + rotation) at any given instant is rotating about some point – this point is the *instantaneous center of zero velocity (IC)*.

It's the point in or out of the object that has zero velocity at that instant, effectively acting as a temporary "pivot."

- **Finding the IC:** If you know the velocity directions of two distinct points on the body, you can find the IC by drawing perpendiculars to those velocity vectors. Their intersection is the instantaneous center. At that instant, the body is in pure rotation about the IC.

- If the body is in **pure rotation** about a fixed point, the IC is obviously that fixed point. If the body is in **pure translation** (all points moving parallel with equal velocity), the IC is at infinity (conceptually, "no finite rotation center" – the object is just sliding straight) [^3].

- **Why it matters:** The IC concept provides a shortcut for velocity calculations. Instead of doing vector algebra, you can treat the motion as pure rotation about the IC. For example, the speed of any point on the body equals ω × (distance to IC). This is extremely handy for linkages and rolling wheels problems on the FE exam.

- **Exam context:** You might see a problem with a rod or link that has one end sliding or pinned, and you're asked for the speed of a point on it. Using the IC can simplify the solution. Another common scenario: a wheel rolling without slipping on a surface – the point of contact with the ground is the IC (zero velocity there). Recognizing that quickly leads you to realize the wheel's center moves with velocity ωR and the top of the wheel moves at 2ωR, for example.

- The **instantaneous center** is also referred to as the "instant center" or "center of instantaneous rotation." It is a kinematic concept – no forces involved, just geometry of motion.

Visual Insight (Finding the IC): Picture a ladder sliding down a wall (one end on the wall, one on the floor). At any instant, one end of the ladder has a velocity straight down, the other end has velocity straight horizontal. Draw a line through the top end, perpendicular to its downward velocity (so a horizontal line through that top end). Draw a line through the bottom end, perpendicular to its horizontal velocity (so a vertical line through the bottom end). Those two lines intersect at the corner between wall and floor – that's the instantaneous center. In that moment, the ladder is effectively rotating about that corner point. This trick works generally: velocity directions known ⇒ perpendicular lines ⇒ IC location.

Exam Handbook Search Cues (Not affiliated with or endorsed by NCEES): *instant center*, *zero velocity*, *instantaneous center of rotation* (These should lead you to the definition or discussion of instant centers in the exam reference.)

Footnotes:

- *IC can lie outside the object:* The instantaneous center doesn't have to be physically on the body. Often, it's off the object or even at "infinity" (when motion is pure translation) [^3]. This is a conceptual tool – don't be surprised if the IC falls off your diagram.

- *Kennedy's Theorem:* If dealing with three bodies moving relative (like three connected links), their three ICs lie on a straight line. This is more for mechanism design; for the FE exam, usually you handle two-body scenarios, but it's good to know in complex linkages the ICs align.

- *Zero velocity means relative to ground (or chosen reference frame):* The IC is defined in the stationary reference frame (typically ground). So "zero velocity" means not moving relative to ground at that instant. It doesn't mean the point is absolutely stationary forever – just that snapshot.

- *Notation:* Sometimes IC is denoted by I with two subscripts indicating the bodies (e.g., $I_1 2\ is\ the\ instant\ center\ of\ body\ 1\ relative\ to\ body\ 2$). In single-body motion relative to ground, you might just call it I or O_{inst}.

Variations and Related Concepts:

- If a wheel **rolls without slipping**, the instantaneous center is the point of contact with the ground (because that point's velocity is zero relative to ground). This is a classic case and often used in exam questions. Using that, one can immediately say the linear velocity of the center of the wheel is $v = \omega R$ (with R being radius), since it's at a distance R from the IC and rotating about it, and the angular velocity of the wheel is ω.

- If a body is **sliding (translating)**, you can think of it as rotating about a point at infinity. Practically, this means all velocity vectors are parallel, and you won't find a finite intersection. In such cases, the concept of IC might not be directly helpful (you revert to straightforward relative velocity calculations), but understanding that helps avoid wasting time looking for an IC that isn't within reach.

- For a **link in a mechanism** (like a four-bar linkage), each pair of connected links has an IC at their joint. More interesting is the IC between two non-adjacent links which you find by intersecting lines as per Kennedy's rule. Though detailed mechanism analysis is beyond FE scope, a conceptual question might appear.

- **Planar vs. 3D:** The "instantaneous center" concept is essentially 2D (planar motion). In 3D motion, you'd talk about an instantaneous axis of rotation (a line) instead. The FE Mechanical Exam will primarily stick to planar scenarios for kinematics.

Special Notes (Calculator/Practical Tips): There's no direct calculator function for finding an IC – it's a graphical/analytical concept. However, on exam problems, do a quick sketch of the velocity directions and draw perpendiculars. This can be done roughly on scratch paper. If numerical coordinates are given for positions and velocities, you can also solve by equations: for two points A and B with velocity vectors known, the IC coordinates (x, y)satisfy $\vec{v}_A = \omega \times \overrightarrow{(x, y)_A}$and $\vec{v}_B = \omega \times \overrightarrow{(x, y)_B}$, which can be solved for $(x, y)$and ω. But that's usually overkill – a geometric approach is faster. Use your calculator just to compute distances or check ratios if needed once you have the IC (for instance, if IC to A distance is D, and $\omega$is needed given v_A, use $\omega = \frac{v_A}{D}$).

Definition/Note Passport: Instantaneous Center of Zero Velocity – The go-to concept for simplifying planar motion by finding a momentary rotation point.

Plain-language Definition: The **instantaneous center of zero velocity** is the point in the plane about which a rigid body is rotating **at that instant**. At that point, the velocity is zero. In other words, if you "freeze" the motion at a specific instant, the body appears to pivot about the IC at that moment.

Where it Matters (Exam Impact): You use the IC to quickly find velocities in problems where a rigid body both translates and rotates. On the FE exam, common uses include determining how fast one point on a body is moving given the velocity of another point, by treating the motion as rotation about the IC. It's especially

handy in mechanism problems (sliders, pin-connected bars) and rolling motion (wheel on surface).

Pitfall/Confusion Point: Many students forget that the IC can be outside the actual object. Also, a point on the object that happens to have zero velocity at one instant might be moving the next instant – *instantaneous* is the key word. Another confusion: thinking the IC is a permanent center of rotation – it's not (it can change from instant to instant as the motion evolves). It's a snapshot concept.

Micro-check: True or False – If a rigid body is in pure translation (no rotation at all), it has no finite instantaneous center of rotation. **(True:** in pure translation, all points move parallel, so their velocity perpendiculars never meet; we say the IC is at infinity.)

Explanation & Analysis: The instantaneous center (IC) concept can seem abstract, but it's actually very practical. It tells us that *any planar motion* of a rigid body can be thought of as a pure rotation about some point at that instant. For example, consider a rolling wheel: even though every part of the wheel is moving, there is one point – the point touching the ground – that is momentarily at rest (assuming no slipping). At that instant, the wheel is effectively rotating about that contact point. This makes it easy to analyze: the wheel's center moves as if it were on the end of a rotating spoke pivoting about the contact point.

To **find the IC**, you use the fact that for a rigid body, all points have velocities consistent with a single rotation about the IC. Let's say you have two points, A and B, on the body, with known velocity vectors $\mathbf{v}_A$ and $\mathbf{v}_B$ (in direction and maybe magnitude). Follow these steps:

1. **Draw velocity vectors** at A and B indicating their direction (and relative magnitudes if known).
2. **At each point, draw a line perpendicular to the velocity vector.** Point A's velocity direction gives a perpendicular line (call it line A), and B's velocity gives line B. These lines represent all possible locations of the IC relative to that point (the IC must lie somewhere on these lines because the point's motion can be seen as rotation around any point on that perpendicular line resulting in that velocity direction).
3. **Locate the intersection** of line A and line B. That intersection is the instantaneous center of zero velocity. By construction, if the body were rotating about that point, points A and B would have exactly the velocity directions we drew – which they do.

Sometimes, one velocity is along a line through a pin or slider, meaning one of those perpendicular lines might actually be along the body or at a right angle to it. The method still holds. If the lines are parallel (which happens if $\mathbf{v}_A$ and $\mathbf{v}_B$ are parallel, i.e., the body is in pure translation), they won't intersect – indicating the IC is "at infinity" and confirming pure translation (no finite rotation center) [^3].

Once you have the IC, **analysis becomes straightforward**: the angular velocity ω of the body can be found by $\omega = v_A / r_{A,IC}$, where $r_{A,IC}$ is the distance from point A to the IC (using the perpendicular distance to the rotation axis) and v_A is the linear speed of point A. Likewise, v_B should equal ω times $r_{B,IC}$ (the distance from B to the IC) – this can serve as a consistency check. The direction of rotation (clockwise vs counterclockwise) can be inferred from the velocity directions: if point A's velocity would be produced by clockwise rotation about IC, then that's the sense of ω (and you should check it matches point B's situation too).

Common pitfalls in exam settings include misidentifying which point has zero velocity (sometimes a point is momentarily stationary if it contacts a surface without slipping), or incorrectly drawing the perpendiculars. Always double-check: the velocity of a point relative to the IC should be perpendicular to the line connecting that point to the IC (because for pure rotation, velocity is tangential to the circle centered at the rotation point). If your perpendicular lines are drawn correctly, the IC is where they meet. Another pitfall is not realizing you've essentially solved the problem once you have the IC: for instance, if the exam asks for the speed of point B and you already have ω from point A and the distance from IC to B, just do $v_B = \omega \cdot r_{B,IC}$. No need for heavy vector math if you leverage the geometry.

In summary, the instantaneous center is a powerful concept that turns a combination of translation and rotation into an easier pure rotation picture. It's a favorite trick for many mechanical engineers because it simplifies understanding of motion. For the FE exam, even if you don't explicitly draw the IC, thinking in these terms can guide you to the right relationships between velocities of different points on a rigid body. It's an almost "magical" pivot that appears for an instant – use it to your advantage to make kinematics problems more intuitive.

K07.T06.S03 – Relative Velocity and Acceleration in a Rotating Rigid Body

Principle Introduction – Subtopic at a Glance:

- In a rigid body, the motion of one point **relative** to another can be described using angular motion. If you know how one point on the body is moving, you can find the velocity or acceleration of another point on the same body by adding the effects of rotation.

- The core idea: $\mathbf{v}B = \mathbf{v}_A + \boldsymbol{\omega} \times \mathbf{r}$. This vector equation says the velocity of point B equals the velocity of point A plus an extra term from the body's rotation (ω cross the position vector from A to B). It's essentially the mathematical formulation of what we did with the instantaneous center – but works for any chosen reference point A.

- For acceleration, a similar relation exists: $\mathbf{a}B = \mathbf{a}_A + \boldsymbol{\alpha} \times \mathbf{r})\}$ $+ \boldsymbol{\omega} \times (\boldsymbol{\omega} \times \mathbf{r}_{BA.Here,} \boldsymbol{\alpha} \times \mathbf{r}$ gives the tangential acceleration component due to angular acceleration, and $\boldsymbol{\omega} \times (\boldsymbol{\omega} \times \mathbf{r})$ yields the centripetal (normal) acceleration component due to rotation.

- **When to use these:** Whenever a rigid body is undergoing general plane motion and you have information at one point and need it at another. For instance, a rod AB has a known speed at end A, and you need speed at end B at the same instant – using $\mathbf{v}B = \mathbf{v}_A + \boldsymbol{\omega} \times \mathbf{r}$ is the direct way.

- **Exam context:** Common cases include linkage analysis (e.g., a bar with one end sliding and the other pinned: find the velocity of the sliding end given the angular speed of the bar, or vice versa). Another is rolling objects: e.g., knowing the center of a rolling wheel's velocity and wanting the top point's velocity (which we know would be greater). The formula handles all these systematically.

- Also, this concept underpins the instantaneous center method. If you set $\mathbf{v}A = \mathbf{0}$ *(point A is the IC), then* $\boldsymbol{v}_B = \boldsymbol{\omega} \times \mathbf{r}$, which matches the idea that B's velocity is purely rotational about A. The general formula is a superset of special cases (pure rotation, pure translation, etc.).

Visual Insight: Consider a door rotating about its hinge (point A = hinge). The hinge A has zero velocity (fixed). For any other point B on the door, $\mathbf{v}B = \mathbf{0} + \boldsymbol{\omega} \times \mathbf{r}$ – the velocity at B is perpendicular to the line from hinge to B, with magnitude ω·(distance AB). Now, imagine the hinge itself is moving (say the whole door is moving to the right while rotating – not common in real doors but think of a moving rotating platform). Then B's velocity would be the sum of the platform's translation (affecting A and B equally) plus the rotation about A. This is exactly what the formula encapsulates.

Exam Handbook Search Cues (Not affiliated with or endorsed by NCEES): *relative velocity*, *rigid body velocity*, *v = ω × r*, *translating axes* (These help locate the section in the handbook that lists these vector equations for relative motion in a rigid body.)

Footnotes:

- *Vector directions:* The cross product $\boldsymbol{\omega} \times \mathbf{r}BA$ *follows the right-hand rule. In planar motion, ω is often taken as a scalar (out-of-plane direction implicitly). Be mindful: if using scalar ω in 2D,* $\omega \times r$ *gives a vector perpendicular to r (tangent direction). Use the correct sense (CW vs CCW) for direction; a quick right-hand rule: point thumb in direction of ω (out of plane for CCW positive), then* $\omega \times r$ *gives thumb × fingers direction for velocity*

- *Notation:* $\boldsymbol{r}$ typically means the position vector from point A to point B (pointing **from A toward B**). Some texts use the opposite ($r_A B$); be sure which way you define it. In $v_B = v_A + \omega \times r_{BA}$, r_{BA} *is from A to B*. If you accidentally use r_{AB} (*from B to A*), you'd get a sign error (the cross product would point the opposite way) [^4].

- *Units check:* ω in rad/s, r in meters (or ft), so ω × r has units of (rad/s) *m = m/s (since rad is dimensionless), matching velocity units. For acceleration: α (rad/s²) × r (m) gives m/s², and ω×(ω×r) effectively ~* $\omega^2 r$ *in magnitude, also m/s², so all terms in the acceleration equation are consistent. A common mistake is forgetting that radian is not a physical unit; treat ω and α as pure numbers with per-time units.*

- Planar simplification: In 2D problems, we often drop the vector notation and use scalar equations with signed magnitudes. For example, in planar motion: $v_{B\,x} = v_{A\,x} - \omega\,(y_B - y_A)$ and $v_{B\,y} = v_{A\,y} + \omega\,(x_B - x_A)$ if ω is into the page (using a coordinate approach). The vector form is cleaner conceptually, but you can break it into components if needed.

Variations, Related Forms, Typical Values:

- **Translating reference frames:** The given formulas assume A and B are on the same rigid body (so they have the same angular velocity ω and angular acceleration α of the body). If A was moving on its own (not rigidly attached), we'd need to account for that relative motion differently. But for rigid bodies, these are straightforward.

- **Alternate approach (instant center):** As mentioned, setting $v_A = 0$ (choosing A as the IC) reduces the general velocity formula to $v_B = \omega\, r_{BA}$ (perpendicular direction). This is consistent and can be a simpler thought in special cases.

- **Acceleration formula breakdown:** The term $\boldsymbol{\alpha} \times \mathbf{r}$ is often called **tangential acceleration** (it's perpendicular to r), and $\boldsymbol{\omega} \times (\boldsymbol{\omega} \times \mathbf{r})$ simplifies to $-\omega^2\,\mathbf{r}$ for planar motion (pointing opposite to r, toward the center of rotation), which is the **centripetal acceleration**. Knowing this, you can use $a_{tan} = \alpha \cdot r$ and $a_{norm} = \omega^2\, r$ as scalar formulas for magnitudes when convenient.

- **Typical magnitudes:** It's hard to generalize values, but remember rotation can amplify linear speed for distant points. For instance, if a rod 2 m long is rotating at ω = 5 rad/s, the tip velocity relative to the hinge is 10 m/s. If that rod's ω is changing at 2 rad/s², the tip's tangential acceleration is 4 m/s², and if ω=5 rad/s at that moment, centripetal acceleration is $\omega^2\, r = 25 * 2 = 50\ m/s^2$. That's significant – rotation can produce high accelerations even at moderate angular speeds, due to the ω² factor. The exam may test conceptual understanding that the farther out you go (larger r), the higher the linear speed and centripetal acceleration for a given ω.

Special Notes: When using these formulas in calculation, it can be helpful to break the cross product into components if you're not fully comfortable with vector cross rules. For 2D, as noted, you can use perpendicular directions: $\omega \times r$ effectively means a 90° rotation of the r vector in the direction of motion. In a Casio or TI calculator, there's no direct vector operation, so you'll be doing component math or scalar relations. One tip: assign a positive rotation direction and stick to it. For example, assume counterclockwise ω is positive (pointing out of page). Then you can append signs to the ωr terms in component equations based on whether the effect is increasing or decreasing the component. With practice, it becomes intuitive ("ω × r" essentially rotates r by +90° if ω is positive out-of-plane).

Equation Passport: Rigid Body Relative Velocity & Acceleration – Allows computation of velocity or acceleration of any point on a rigid body, given those of another point and the body's rotational motion.

Name & Purpose: Relative Motion Equations for Rigid Bodies – These equations provide the relationship between the velocities and accelerations of two points on the same rigid object. They are used to translate motion info from one point to another, accounting for rotation of the body.

Equations:

Velocity: $\vec{v}_B = \vec{v}_A + \vec{\omega} \times \vec{r}_{B/A}$

Acceleration: $\vec{a}_B = \vec{a}_A + \vec{\alpha} \times \vec{r}_{B/A} + \vec{\omega} \times (\vec{\omega} \times \vec{r}_{B/A})$

Variables:

- $\mathbf{v}_A, \mathbf{v}_B$ = velocity vectors of point A and point B, respectively (m/s). These are absolute velocities in the ground frame.
- $\mathbf{a}_A, \mathbf{a}_B$ = acceleration vectors of A and B, respectively (m/s²).
- $\boldsymbol{\omega}$ = angular velocity vector of the rigid body (rad/s). For planar motion, $\boldsymbol{\omega}$ is perpendicular to the plane (e.g., along ±k axis); its magnitude is the scalar rotational speed and direction denotes sense (CW or CCW).
- $\boldsymbol{\alpha}$ = angular acceleration vector of the body (rad/s²), also perpendicular to the motion plane in planar cases.
- $\mathbf{r}BA$ = *position vector from point A to point B (pointing from A toward B) (m). If coordinates of A and B are known,* $\boldsymbol{r}$ in a 2D coordinate sense. } = $\cancel{AB} = (x_B - x_A)\hat{\imath} + (y_B - y_A)\hat{\jmath}$

Assumptions:

- Points A and B are fixed on the same rigid body (distance between them is constant). This derivation comes from that rigidity condition and relative motion analysis.
- The reference frame is inertial (typically the ground). We're not adding any pseudo-forces or fictitious accelerations here – just physical motion.
- $\boldsymbol{\omega}$ and $\boldsymbol{\alpha}$ are the rotational velocity and acceleration of the body **as seen in the ground frame**. If the entire body is rotating relative to a moving frame, make sure to account for the moving frame's motion in $\mathbf{v}_A$ and $\mathbf{a}_A$. (This gets into accelerating reference frames, which is usually beyond FE exam scope – FE problems will usually give data in a ground-fixed reference or something equivalent.)
- Planar motion simplification: ω and α are effectively scalars (with an implicit direction). The cross product formula is a vector form that works generally; in 2D you might use scalar versions with signed k components.

Limit Checks:

- **No rotation (ω = 0, α = 0):** Then $\mathbf{v}_B = \mathbf{v}_A$ and $\mathbf{a}_B = \mathbf{a}_A$. This makes sense: if the body isn't rotating at all, every point has the same velocity and acceleration (pure translation). The formulas reduce to that scenario correctly (since cross products become zero).
- **Point A = Point B ($\boldsymbol{r}_{BA} = 0$):** Then obviously $\mathbf{v}B = \mathbf{v}_A$ *and* $\boldsymbol{a}_B = \mathbf{a}_A$. *The equations handle this: if* $\boldsymbol{r}_A$. This is a good sanity check on the form. } = $\mathbf{0}, all\ the\ cross\ product\ terms\ are\ zero, giving \mathbf{v}_B = \mathbf{v}_A, \mathbf{a}_B = \mathbf{a}$
- **A chosen as IC ($\boldsymbol{v}_A = 0$):** If you pick A such that it's instantaneously at rest (like a pin or contact point), then $\mathbf{v}B = \boldsymbol{\omega} \times \mathbf{r}$}, which matches the intuitive rotation-about-A formula. For acceleration, if A is fixed (no motion), then $\mathbf{aB} = \boldsymbol{\alpha} \times \mathbf{r}$). This reflects purely rotational acceleration of B about A, which consists of tangential (α × r) and centripetal (ω×(ω×r)) parts. All good checks. } + $\boldsymbol{\omega} \times (\boldsymbol{\omega} \times \mathbf{r}_{BA}$
- **Extreme case:** If B is much farther from A, any given ω will produce larger v_B $(linearly\ increasing\ with\ r)$. And the centripetal term grows with r as well (ω^2 r). So qualitatively, far out points on a rotating body move faster and have larger normal acceleration – consistent with expectations (and caution: if numbers get big, it's a clue that maybe you made ω too large or chose wrong units).

Use vs. Sibling Equations: Use these **rigid body formulas instead of treating points independently.** For example, don't try to apply $v = \omega r$ separately to two different points without relating them – that could lead to wrong conclusions if there's also overall translation. The above equations inherently combine translation (through $\mathbf{v}_A$ and $\mathbf{a}_A$ terms) and rotation (through cross products). Another related concept is **relative motion of two separate bodies** (like gear A relative to gear B) – that is different; these formulas are for two points on *the same body*. If you have two bodies in contact or gears meshing, you'd use kinematic constraints (like equal tangential velocity at contact for rolling without slip) rather than this formula.

Common Exam Traps:

- **Wrong direction for ω × r:** In a hurry, students sometimes add/subtract the ωr term without considering its direction. A sign mistake can cost the problem. Always determine the direction: if the body rotates clockwise, point B moves in the direction perpendicular to A→B line, rotated clockwise from A's perspective. It might help to physically imagine or sketch the scenario, or use a small right-hand rule analysis [^4].
- **Mixing up $\boldsymbol{r}_B A$ vs $r_A B$:** As noted, $\mathbf{r}BA$ *is from A to B. If you inadvertently use the vector from B to A in the cross product, you'll get* $\boldsymbol{v}_B = \mathbf{v}_A - \boldsymbol{\omega} \times \mathbf{r}$. That minus sign is easy to miss. A good practice is to always write it as B = A + (ω×r); i.e., the second subscript matches the point on the left of the equation. Here, B is on left, so use $r_B A\ (from\ A\ to\ B)$.
- **Forgetting the ω×(ω×r) term in acceleration:** It's common to remember to add the $\boldsymbol{\alpha} \times \mathbf{r}$ part (since that parallels the velocity formula's structure), but forget the second term. The $\boldsymbol{\omega} \times (\boldsymbol{\omega} \times \mathbf{r})$ term is crucial as it represents the centripetal acceleration. Missing it will typically yield an answer missing the inward acceleration component and will be wrong if the problem expects total acceleration. If you're unsure, recall that acceleration of B relative to A in rotation should have both tangential (proportional to α) and normal (proportional to ω^2) parts.
- **Plugging numbers without vector sense:** Another trap is to treat the formula $\mathbf{v}_B = \mathbf{v}_A + \omega \times r$ as if it's just $v_B = v_A + \omega r$ in magnitude blindly. That's only true if directions align perfectly. In general, these are vectors, so you must consider the geometry. If the exam question provides magnitudes and directions separately, handle them carefully – sometimes it's easier to break into components or use the IC method as a shortcut.

Explanation & Analysis: The relative velocity formula is essentially telling us that any motion of the rigid body can be decomposed into a translation plus a rotation. $\vec{v}_A$represents the translation part (if point A is moving, that movement adds to point B as well), and $\omega \times \vec{r}$is the additional velocity B has because of the body's rotation about A. Think of $\vec{v}_A$as "if the whole body were just moving without rotating" and $\omega \times \vec{r}$as "the extra motion of B around A due to rotation."

To see it in action, imagine a sliding and rotating rod example: one end A of a rod is in a slot moving horizontally, and the rod is also rotating. Suppose at some instant, end A has velocity 2 m/s to the right, and the rod's angular velocity is 3 rad/s clockwise. We want B's velocity. We choose A as our reference: $\vec{v}_A =$ (2 m/s) $\hat{\mathbf{i}}$(assuming +x to the right), and $\vec{\omega} = 3$ rad/sinto the page (clockwise). Now, $\vec{r}_{B/A}$(from A to B) might be, say, a rod of length $L = 1$ mat some angle. We'd compute $\vec{\omega} \times \vec{r}_{B/A}$: its magnitude will be $|\ \vec{\omega}\ |\ L = 3 \cdot 1 = 3$ m/s, and the direction will be perpendicular to the rod (tangent to the rotation). If the rod is angled such that B is "above" A, the cross product gives a velocity component for B that may be downward if the rotation is clockwise. Add that vector to $\vec{v}_A$. The result gives B's velocity vector. This matches what we'd get by thinking "point B moves as a combination of A's translation plus rotation about A."

For **acceleration**, it's similar but with two rotational pieces: $\boldsymbol{\alpha} \times \mathbf{r}$ (like the change in rotational speed giving a tangential acceleration) and $\boldsymbol{\omega} \times (\boldsymbol{\omega} \times \mathbf{r})$ (the fact that if you're going in a circle, even at constant speed, you feel an inward acceleration). If we continue the

rod example, if the rod also has an angular acceleration (say α = 4 rad/s² clockwise at that moment), point B's acceleration relative to A has a component α×r (magnitude 4*1 = 4 m/s², perpendicular to rod, pointing in tangential direction) and a component ω×(ω×r) which ends up magnitude ω² L = 9 m/s² pointing toward A (centripetal). And plus, if A itself had some acceleration (maybe the slot's acceleration), that adds to both.

In solving problems, you might not always explicitly write these vector equations; sometimes using them conceptually is enough. For velocity, one common approach is: break the motion into translation plus rotation. For acceleration, do the same but remember both parts of rotational accel. The equations guarantee you won't miss anything.

One **practical check**: After computing B's velocity or acceleration, consider special cases to ensure you did it right. For instance, if the numbers suggest B is moving faster than A, is that expected? If the rotation direction was clockwise, did B's velocity end up in the correct direction relative to A? These vector equations are very powerful, but with power comes the possibility of sign mistakes. By double-checking with physical reasoning (like the IC method or just visualization), you can catch errors. For example, if you predicted B should be moving downward but your calculation gave an upward velocity, you know something's off with the sign in $\omega \times r$.

In conclusion, mastering the relative motion equations means you have a systematic way to tackle any rigid body kinematics problem. It's the algebraic counterpart to the graphical IC method. On the FE exam, either method works – use whichever you're more comfortable with. The nice thing about the equations is that they extend to acceleration easily, whereas the IC method is mainly a velocity tool. So it's worth getting comfortable with the $\omega \times r$ concept and remembering to include centripetal acceleration for the acceleration part. With these, you'll be equipped to handle things like "the acceleration of a pendulum bob at a given instant" or "the velocity of a piston connected to a crank" swiftly and correctly.

K07.T06.S04 – Mass Moment of Inertia and Parallel-Axis Theorem

Principle Introduction – Subtopic at a Glance:

- The **mass moment of inertia (I)** of a rigid body about an axis is a measure of how the mass is distributed relative to that axis – effectively, how hard it is to spin the object about that axis. It is the rotational counterpart of mass in $F = ma$ (in the same way that mass quantifies resistance to linear acceleration, moment of inertia quantifies resistance to angular acceleration).

- **Definition:** $I = \int r^2\, dm$ for a given rotation axis (where r is the distance from the axis to each little mass element *dm*). In practice, you use known formulas for standard shapes (provided in references or derived) rather than performing integrals from scratch on the exam. Many problems involve finding the moment of inertia about an axis that is not through the object's center of mass. That's where the **Parallel-Axis Theorem** comes in. It states: $I_{\text{new}} = I_c + md^2$, where I_c is the moment of inertia about the parallel axis that passes through the center of mass (the centroidal axis), $m$is the total mass, and d is the perpendicular separation between the two axes. This theorem lets you "shift" a known I to a new axis without re-integrating.

- **Why it matters for the FE Exam:** Dynamics problems often require computing rotational kinetic energy ($\frac{1}{2}\, I\, \omega^2$), or using $\tau = I\alpha$ (moment equation). You might need to combine moments of inertia of multiple parts, or shift an inertia to a different axis in a problem (like finding the inertia of a pendulum about the pivot when you know it about the center). Understanding I and how to manipulate it is essential for solving these.

- Also, distinguishing **mass moment of inertia** from **area moment of inertia** is crucial. Mass moment (this subtopic) deals with dynamics (units kg·m² or slug·ft²), whereas area moment (from Mechanics of Materials, units m^4 *or* in^4) deals with bending stiffness. The exam expects you to know the difference and use the right one in context. Here we focus on mass moments for dynamics.

Visual Insight: Consider a thin rod of mass *m* and length *L*. If you spin it about its center, it's relatively easy – the mass is evenly distributed around the center. If you spin it about one end, it "feels" heavier to spin because more mass is far from the axis. Numerically, $I_{center} = \frac{1}{12}\, mL^2$, but $I_{end} = \frac{1}{3}\, mL^2$, which is four times bigger. The parallel-axis theorem explains this jump: the end axis is a distance d = L/2 away from the center axis, so $I_{end} = I_{center} + m(L/2)^2 = \frac{1}{12}mL^2 + \frac{1}{4}mL^2 = \frac{1}{3}mL^2$. The visual takeaway: moving the axis away from the centroid increases I by a factor of *md²*. The further the axis, the larger the inertia – which aligns with the idea that more mass is "swinging out" at larger radii.

Exam Handbook Search Cues (Not affiliated with or endorsed by NCEES): *mass moment of inertia*, *I* = ∫*r² dm*, *parallel axis*, *radius of gyration* (These will locate the inertia formulas section in the handbook and the parallel-axis theorem blurb.)

Footnotes:

- *Units:* In SI, mass moment of inertia is in kg·m². In US Customary, it's slug·ft² (be careful: sometimes lbf·ft·s² is used equivalently since slug = lbf·s²/ft). Don't confuse this with area moment (e.g., in^4 *or* m^4). They are different concepts [^5].

- *Common symbols:* I is the general symbol for moment of inertia (with subscripts or context to clarify which axis). Sometimes I_G or I_{cm} denotes moment about the center of mass (G for centroid). I_x, I_y, I_z might denote about specific axes. k is often used for **radius of gyration**, defined by $I = mk^2$ (i.e., $k = \sqrt{I/m}$). Radius of gyration gives a length that represents the object's mass distribution – "if you concentrate mass m at distance k from axis, you get the same I."

- *Parallel-axis vs. perpendicular-axis:* Don't mix them up. Parallel-axis theorem (for 3D mass distribution or planar area) adds md^2 when shifting parallel. Perpendicular-axis theorem is a different rule for planar **area** moments ($I_x + I_y = I_z$ *for a flat shape*). The FE mechanical exam primarily uses parallel-axis for mass moments (e.g., for composite bodies or pendulums).

- *Scope:* For FE purposes, you usually won't have to derive I via integration. Either a formula is given, or you apply parallel-axis. Know the formulas for common shapes: rod, rectangular plate, solid cylinder, thin hoop, spherical shell, solid sphere, etc., or at least know how to find them in the handbook quickly. A typical exam question might say "a solid disk of mass m and radius R rotates about an axis tangent to its rim; find its moment of inertia about that axis." You'd take $I_{center} = \frac{1}{2}mR^2$ (for solid disk about center) and then add mR^2 (because the new axis is distance R away from center) to get $I_{tangent} = \frac{1}{2}mR^2 + mR^2 = \frac{3}{2}mR^2$.

Variations and Related Forms:

- **Radius of Gyration (k):** As mentioned, $k = \sqrt{I/m}$. It's basically an alternative way to express I. Some problems might give you k instead of I directly, especially in structural contexts, but in dynamics it's less common. Still, if you see "radius of gyration," know it's telling you how far from the axis you can imagine the mass concentrated. For example, if a body has k = 0.5 m about some axis, and mass m = 20 kg, then $I = 20(0.5)^2 = 5\ \mathrm{kg \cdot m^2}$.

- Composite bodies: If you have a system of masses or a shape composed of simpler shapes, the total I about a given axis is the sum of each part's I about that axis. This is super useful – e.g., a dumbbell (two masses on a rod): $I_{total} = I_{rod} + I_{mass1} + I_{mass2}$ (each term possibly using parallel-axis to get to the common axis). The exam might implicitly test this by giving, say, a wheel (which is a combination of rim and spokes or something) and seeing if you sum moments correctly.

- Thin vs. thick: The formula for I can depend on how mass is distributed in thickness. For instance, a thin hoop (all mass at radius R) has $I = mR^2$. A solid disk (mass spread from center to R) has $I = \frac{1}{2}mR^2$. A thin spherical shell vs a solid sphere: shell $I = \frac{2}{3}mR^2$, solid sphere $I = \frac{2}{5}mR^2$. These differences come from the r^2 dm integration, but you might just remember a few key ones. Typically, the more mass is towards the outside, the higher the I (hence the hoop is mR^2 which is bigger fraction than disk's half).

- Units sanity: 1 kg·m² is not a huge inertia (consider a 1 kg mass at 1 m radius spinning). For a car wheel (say 10 kg, radius 0.3 m), moment of inertia might be around $100.3^2/2 \approx 0.45$ kg·m² (solid disk approximation). For a heavier system, maybe tens or hundreds of kg·m². Just be mindful of unit conversions: if you have weight in newtons, convert to mass in kg (m = W/g). And if using imperial, if given weight in lbf, convert to mass in slugs by dividing by 32.174 ft/s² before computing I in slug·ft² [^5].

Special Notes (Calculator Usage): There is usually no tricky calculator function needed here; it's straightforward arithmetic. However, ensure you square the distance in the parallel-axis formula (it's d^2!). Sometimes students might mistype: e.g., if m = 50 kg and d = 0.2 m, $md^2 = 50(0.2)^2 = 500.04 = 2$ kg·m² (not $50 * 0.2 = 10$!). It can help to use your calculator's memory or parentheses carefully to avoid mistakes. For composite inertia calculations, break them into parts and maybe tabulate values to avoid confusion. On the allowed calculators, using the multi-line display (for TI-36X Pro or Casio) or storing interim results in letter variables can keep things clear if the problem is complex. But generally, these problems are simple enough to just compute directly.

Equation Passport: Parallel-Axis Theorem – Shifts a known moment of inertia to a new axis at a distance *d*.

Name & Purpose: Parallel-Axis Theorem – Allows calculation of the mass moment of inertia about any axis parallel to one through the object's center of mass. It's used to adjust a centroidal inertia to an off-center axis. Essential for when you need *I* about a pivot or hinge given *I* about centroid (or vice versa).

Equation: $I_{new} = I_c + m\,d^2$

Variables:

- I_{new} = mass moment of inertia about the new axis (kg·m² in SI, slug·ft² in US units). This is what you want to find.
- I_c = mass moment of inertia about a parallel axis through the object's center of mass (centroid) (same units as above). This is the known/reference inertia. Often denoted I_G or I_{cm}.
- m = total mass of the object (kg or slug).
- d = perpendicular distance between the new axis and the centroidal axis (m or ft). It should be the shortest distance between the two axes (i.e. a right-angle distance).

Assumptions:

- The two axes are parallel (and never intersect). If they intersect, they're not parallel – you'd then need a different approach (e.g., use perpendicular-axis theorem in 2D or more complex inertia tensor transformations in 3D, which is beyond FE scope).
- One axis passes through the object's center of mass. The formula specifically uses the centroidal axis as the base. You can actually apply it sequentially (e.g., shift from centroid to one axis, then from that axis to another), but it's safest to go directly from centroid to target in one step if possible.
- The object is rigid and its mass distribution is fixed. We're not changing the shape, just imagining measuring its inertia about a different axis.
- We assume flat space geometry – in other words, d is small relative to, say, Earth's radius (joking – basically, normal engineering conditions; no relativistic or weird effects!).

Limit Tests:

- If $d = 0$, then $I_{new} = I_c$. This is trivial but important: shifting by zero (same axis) changes nothing. Good consistency check – the formula gives identical inertia if you haven't moved the axis.
- If mass $m \to 0$ (an extremely small mass object), then $I_{new} \to 0$ as well. A tiny mass has tiny inertia regardless of axis, which is sensible.
- If d is very large, the $m\,d^2$ term dominates. Physically, if you move the rotation axis very far from the mass, inertia becomes huge – which aligns with the idea that it's extremely hard to rotate an object about an axis far away (it has to "fling" the mass around a big circle). For example, think of swinging a ball on a string – the longer the string (greater d), the more resistance you feel to accelerating it (higher I).
- Units consistency: The formula $m\,d^2$ gives kg * m² = kg·m², same units as I, so that checks out. If your units come out odd (like forgetting to square d would give kg·m which is wrong), that's a red flag.
- **Use vs. Sibling Equations:** Use the parallel-axis theorem **instead of re-integrating** whenever you need an inertia about a new axis parallel to a known one. It's a huge time-saver and reduces error potential. Do not confuse it with formulas for converting between different orientations; it only works for parallel shifts, not for axes at angles to each other. Also, this is for mass moments – for area moments of inertia (like in bending of beams), a similar formula $I_{new} = I_{centroid} + A\,d^2$ exists (where A is area), but be careful to apply the right version in the right context. In dynamics problems, stick to mass and mass moments.

Common Exam Traps:

- **Using the wrong d:** Make sure d is measured **between the axes**, not between surface points or edges of the object. For instance, if you have a cylinder and want to shift from center axis to a tangent axis, d is the radius of the cylinder. If you accidentally use diameter, you'll square that and get four times too large an addition. Draw a sketch to identify the two axes and measure the perpendicular distance between them.
- **Forgetting to include the object's full mass:** Sometimes a problem might give weight (W) and you need mass (m = W/g) for SI, or give mass directly. In composite scenarios, you should use the mass of the specific component when shifting that component's I. A mistake would be to use the total system mass in a single application of md^2 for all parts – instead, do each part separately or compute an overall centroid first.
- **Mixing up area vs mass moment:** If the problem is about dynamics (e.g., a pendulum swinging), you need mass moment of inertia. There have been cases where examinees mistakenly use an area moment or formula from the Mechanics of Materials section (like $I = bh^3/12$ for a beam cross-section) instead of mass moment. Remember: mass moment involves mass distribution (with density if needed). Area moment is unrelated to mass; it's for structural bending. The exam might provide both sets of formulas in different handbook sections – be sure to grab from the correct section. A clue: mass moments will involve the mass or density in the formula, area moments won't.
- **Arithmetic slips in md^2:** It's such a short formula, but squaring d and multiplying by m can produce errors if done sloppily. Double-check the arithmetic – a simple way is to compute d^2 first (in your calculator) then multiply by m, then add I_c. If an answer choice is off by a factor (like exactly 4× or something), it might indicate a mis-squared distance.

Explanation & Analysis: The mass moment of inertia, I, fundamentally comes from $I = \int r^2\, dm$. This integral adds up $m \cdot (distance\ to\ axis)^2$ for every little piece of the object. So pieces of mass that are farther from the axis contribute disproportionately more (since distance is squared). That's why shape and axis location matter so much. For example, a flywheel concentrates mass outward to maximize I for a given mass (good for energy storage), whereas a figure skater pulling arms in brings mass closer to spin faster (reducing I).

On the FE exam, you won't be asked to perform complex inertia integrals. Instead, you will either recall a standard formula or use the parallel-axis theorem to adjust one. The handbook includes a list of standard I formulas for common shapes (like rods, plates, cylinders, spheres). A smart strategy is to memorize a few and know how to derive others quickly if needed. But often, applying the parallel-axis theorem is the quickest way: if you recognize the object's centroidal inertia, just shift it.

For instance, if a problem involves a pendulum – say a solid disk of radius R attached to a rod, swinging about an axis at the top of the rod – you might need the disk's inertia about the pivot. If you know the disk's I about its center ($1/2\, mR^2$), and the pivot is a distance L above the disk's center, you do $I_{pivot} = 1/2\, mR^2 + mL^2$. Similarly, for a rod about one end, from center formula $1/12\, mL^2$ you get $1/12\, mL^2 + m(L/2)^2 = 1/3\, mL^2$ as earlier. So it's straightforward if you identify m and d correctly.

A subtle point: the parallel-axis theorem can be used in reverse as well – if you somehow know I about an off-center axis and want I about the center, you can rearrange: $I_c = I_{off-center} - m\, d^2$. Just ensure the off-center axis is parallel and distance d away. For example, the polar moment of inertia of a rod about one end is $1/3\, mL^2$. Using the theorem in reverse with d = L/2, you'd compute $I_{center} = I_{end} - m(L/2)^2 = 1/3\, mL^2 - 1/4\, mL^2 = 1/12\, mL^2$. This can be useful if an exam question gives an inertia about some axis and asks for inertia about a centroid (less common, but possible in a conceptual sense).

Mass distribution insight: Knowing typical values or fractions helps. We listed a few earlier: hoop mR^2 (all mass at radius R), disk $0.5\, mR^2$, sphere $0.4\, mR^2$ (solid) or $0.667\, mR^2$ (shell). Rod about center $0.083\, mL^2$, rod about end $0.333\, mL^2$. These ratios (like 1/2, 1/3, etc.) are good to keep in mind. They not only help in quick calculation but also in checking if your result is reasonable. If you got an inertia larger than mR^2 for something that clearly has some mass near the axis, you likely erred – because mR^2 is the max for a given m and radius (all mass at edge). Conversely, if you got smaller than the smallest possible (some distributions yield lower fractions, but there's generally logical bounds like >0 obviously, but also comparisons between similar shapes).

In problem-solving, after computing an inertia, consider how it will be used: often you'll plug it into equations like $T = \frac{1}{2} I\omega^2$ (kinetic energy) or $\tau = I\alpha$ (rotational analog of F=ma). If your I is off, the resulting energy or acceleration will be off. For example, if you mix up units and use weight in place of mass in I, you might be off by factor of g, leading to an answer that might not match any option – or worse, match a wrong option if the exam anticipated that mistake.

To sum up, mass moment of inertia and the parallel-axis theorem are about understanding how geometry and mass distribution affect rotational inertia. Use the theorem to avoid re-deriving known results, be careful with units and distances, and double-check your results against intuitive expectations. With those precautions, these problems become one of the more straightforward plug-and-chug parts of dynamics on the FE exam, since it often boils down to applying a formula correctly.

Footnotes:

[^1]: **Radians, not degrees:** In calculus relations like $\omega = d\theta/dt$, θ must be in radians for the derivative to have physical meaning in standard units. 1 rad = 57.3°, but treat "rad" as a placeholder indicating an angle, not a separate unit like meter (hence ω in rad/s is often just written s^{-1}). Always convert degrees to rad before using these formulas to avoid errors.

[^2]: **Sign convention for rotation:** By tradition (right-hand rule), counterclockwise rotation is taken as positive angular velocity (ω > 0 coming out of the page) in most exam problems, unless stated otherwise. Clockwise would then be negative. Stick to a convention consistently within a problem.

[^3]: **"IC at infinity":** Saying the instantaneous center is at infinity is a way of describing pure translation. It means if you try to find an intersection of velocity perpendiculars, they never meet within a finite distance. In practical terms, it indicates no rotation at that instant – just straight-line motion.

[^4]: **Right-hand rule practice:** If **ω** is out of the page (CCW rotation), then **ω** × **r***BA is a vector perpendicular to* ***r***} in the plane. You can determine the direction by pointing your right thumb out of page (direction of ω) and fingers along **rBA** *(from A to B); your palm push gives direction of v* component. Alternatively, remember that the velocity of B relative to A is perpendicular to line A–B, such that it would rotate A towards B's position.

Topic 07 - Kinematics of Mechanisms

Topic Introduction: *Kinematics of mechanisms* is the study of motion in linked mechanical systems without considering the forces or masses involved. In plain terms, it's about figuring out how fast things move or accelerate in a mechanism given how other parts are moving. This matters on the FE Mechanical Exam because many machine components (like engines, pumps, or linkages) involve rotating parts driving sliding parts. A classic example is the slider-crank mechanism, which converts rotational motion to linear motion (think of a piston in an engine). On exam day, you might see questions asking for the velocity or acceleration of one part of a mechanism (e.g. a slider) given information about another part (e.g. a rotating crank). These questions test your ability to apply geometry and calculus to relate motions – a fundamental skill for mechanical design. Typically, the problem will give you a configuration (angles, lengths) and an input motion (an angular velocity or acceleration), and you'll need to find an output motion (usually a linear velocity or acceleration). Being comfortable with mechanism kinematics means you can quickly write the loop equations or use instant center methods to find the relationships. In summary, this topic gives you the tools to analyze how mechanisms transmit and transform motion – critical for designing everything from engines to robotic linkages, and highly testable in the FE exam context.

K07.T07.S01 – Velocity and Acceleration in Slider-Crank Mechanisms

- **Four-Bar Mechanism Basics:** A slider-crank is essentially a four-bar linkage where one moving link slides instead of rotating. It has four "links": (1) the ground (fixed frame), (2) the crank (rotating input arm), (3) the connecting rod (coupler link), and (4) the slider (output link that moves linearly). This mechanism is found in engines (crankshaft and piston) – the crank (link 2) rotates about a fixed pivot, pushing the connecting rod (link 3) which in turn drives the slider (link 4) back and forth.
- **Loop-Closure Geometry:** The positions of the crank, connecting rod, and slider are related by a geometric loop equation. Essentially, as the crank rotates through an angle θ_2, the slider's position **x** changes to maintain the pin connection with the connecting rod. The core geometry for an in-line slider-crank: if the crank length is **R** and the connecting rod length is **L**, and the crank angle θ_2 is measured from the slider's line of travel, the slider's distance from the crank pivot is determined by the loop relation $(x - R\cos\theta_2)^2 + (R\sin\theta_2)^2 = L^2$. This comes from the right triangle formed by the crank and the connecting rod[^geometry]. Solving that equation gives the slider position: $x(\theta_2) = R\cos\theta_2 + \sqrt{L^2 - R^2\sin^2\theta_2}$ (using the "open" configuration, where the connecting rod doesn't cross over the crank).
- **Velocity by Differentiation:** To get the slider's velocity $\mathbf{v}_{(B)}$, we differentiate the position with respect to time. Intuitively, as the crank spins faster (higher ω_2), the slider's speed increases, but it also depends on the crank angle – it's zero at the extreme positions (when the crank is aligned with the slider) and peaks somewhere in between. We can derive a formula for $\mathbf{v}_{(B)}$ either by implicit differentiation of the loop equation or via relative velocity diagrams. The result ties together the crank's angular velocity ω_2, the crank angle θ_2, and the geometry (R and L).
- **Acceleration by Differentiation:** Differentiating velocity gives the slider's acceleration $\mathbf{a}_{(B)}$. There are two contributions: one from the crank's angular acceleration α_2 (if the crank speeding up or slowing down), and one from the centripetal effect of the crank's rotation (ω_2^2 terms). Again, the crank angle plays a big role – for instance, at mid-stroke the slider might experience a large deceleration due to the crank's change in direction, whereas at the ends the acceleration is largely directed along the slider's line of travel to reverse its motion.
- **Exam Relevance:** On the FE Exam, you might be given a slider-crank scenario with numbers. **Typical question:** "Given a crank of length R connected to a slider by a rod of length L, with the crank at angle θ and rotating at ω (rad/s), find the velocity of the slider" (or acceleration if ω is changing). Sometimes the question is conceptual (e.g. asking at what crank angle the slider reaches max speed or zero acceleration). You won't have to re-derive the formulas from scratch under exam pressure – instead, you should recognize the scenario and know how to quickly get the relationship either from the provided reference or by reasoning through geometry.
- **Method Choice:** If you forget the direct formula, remember you can always fall back on writing the position relation and differentiating, or using an instant center approach. For a slider-crank, the instant center method says the velocity of the slider can be found by finding the instantaneous center of rotation of the connecting rod. But most often, using the geometry and calculus is straightforward. Make sure to keep track of units (convert rpm to rad/s) and use a consistent sign convention for velocity direction.

Exam Handbook Search Cues (Not affiliated with or endorsed by NCEES): *"four-bar linkage", "slider-crank", "velocity analysis", "acceleration analysis", "instant center"* (keywords to locate relevant equations in the reference handbook if needed).

Equation Passport – Slider-Crank Velocity (Relative Motion)

Name and Purpose: Slider-Crank Velocity Equation – Computes the linear velocity of the slider (link 4) from the angular velocity of the crank (link 2) in a slider-crank mechanism. It gives the instantaneous speed of the sliding link for a given crank angle and angular speed, reflecting how rotational motion converts to linear motion.

Equation (Slider Velocity): The velocity of the slider **B** is obtained by differentiating the position constraint. One convenient form of the result is:

$$v_B = -R\,\omega_2 \sin\theta_2 \left(1 + \frac{R\cos\theta_2}{\sqrt{L^2 - R^2\sin^2\theta_2}}\right).$$

In expanded form, this is equivalent to:

$$v_B = -R\,\omega_2 \sin\theta_2 - \frac{R^2\,\omega_2 \sin\theta_2\cos\theta_2}{\sqrt{L^2 - R^2\sin^2\theta_2}},$$

which explicitly shows the two additive components of the slider's velocity.

Variables and Units:

- v_B – Slider's linear velocity (m/s). Positive when the slider moves in the defined positive direction (usually taken as the extending direction).
- R – Crank length (m), the distance from the crank's rotation center O_2 to the crank-pin at A.
- L – Connecting rod length (m), the distance between the crank-pin (A) and the slider-pin (B).
- θ_2 – Crank angle (radians). Angle of link 2 measured from the line of slider travel (ground link 1). $\theta_2 = 0°$ typically corresponds to the crank aligned with the slider's path (slider at an extreme position).
- ω_2 – Angular velocity of the crank (rad/s). Positive direction is usually taken as the direction of crank rotation that drives the slider outward (you can choose CW or CCW consistently with θ_2). *(Note: Convert rev/min to rad/s if needed[^units].)*

Assumptions and Scope:

- Planar mechanism: All motion is in a plane, and the slider moves along a straight line on that plane.
- Rigid links and pin joints: No flexibility or backlash, so the geometric relations hold exactly.
- The formula assumes the "open" configuration of the linkage (connecting rod not folded back on itself). In the crossed configuration, the same formula applies for magnitude, but sign conventions for θ_2 or the interpretation of the square root may differ (the handbook typically provides one case; be mindful if the linkage is crossed).
- Quasi-static or kinematic analysis: We assume the crank's speed is given (as if by a motor) and we are not computing forces. This is purely kinematics (motion geometry) without dynamics.

Limit Tests (Sanity Checks):

- **Crank at 0° or 180° (Dead Center):** $\theta_2 = 0°$ or $180°$ makes $\sin\theta_2 = 0$. The formula gives $v_B = 0$, which makes sense – at the very ends of the stroke, the slider momentarily stops and reverses direction.
- **Crank at 90° (Mid-Stroke):** $\theta_2 = 90°$ (assuming the crank was aligned such that this is halfway through travel) gives $\sin\theta_2 = 1, \cos\theta_2 = 0$. Then $v_B = -R\,\omega_2$, meaning the slider's speed equals $|R\,\omega_2|$. This aligns with intuition: when the crank is perpendicular to the slider's line, the connecting rod is vertical, so all of the crank's instantaneous motion is directly translating into slider motion. The negative sign just indicates the slider's direction relative to our coordinate (if we set increasing x to the right, and if the crank is moving the slider to the left at that instant, v_B comes out negative).
- **Long Connecting Rod (L >> R):** If the connecting rod is much longer than the crank, the term $R\cos\theta_2/\sqrt{L^2 - R^2\sin^2\theta_2}$ becomes small (since $L^2 - R^2\sin^2\theta_2 \approx L^2$ for large L). Then $v_B \approx -R\,\omega_2\sin\theta_2$. In other words, the slider's motion approaches simple harmonic motion, where the horizontal component of the crank's velocity dominates. This is consistent with the idea that an extremely long connecting rod imposes very little nonlinear constraint – the slider basically moves as if on a sine wave based on the crank's projection.

Use vs. Sibling Equations: Use this slider-crank velocity equation instead of the simpler rotation formula $v = \omega r$ when the output link is a translating slider rather than a rotating link. In a pure rotation (like a wheel or a gear), points move in circles (use $v = \omega \times$ radius). But for a slider-crank, the motion is constrained by the linkage geometry – the slider's velocity is not just $R\omega_2$, it's modulated by the crank angle and the connecting rod. In other words, don't assume the slider speed equals the tangential speed of the crank unless $\theta_2 = 90°$; you must account for the geometry (the coupling via link 3). An alternative method to get v_B is the **Instant Center approach**: find the instantaneous center of rotation of link 3 (connecting rod) and use velocity ratios, but the formula above is usually quicker in exam settings.

Common Exam Traps:

- *Unit Mix-ups:* Ensure ω_2 is in radians per second. A common mistake is to plug rpm or deg/s directly into the formula. Remember 1 rpm $= \frac{2\pi}{60}$ rad/s. If you're using the formula from the handbook, it expects SI units by default [^units].
- *Angle Misinterpretation:* Make sure you know what angle is given in the problem. Is it the crank angle from horizontal (as we assumed)? If the problem states an angle from some other reference, adjust accordingly. Sometimes exam questions might give the angle of the connecting rod or the slider position instead – be ready to relate that to θ_2. A pitfall is using the connecting rod's angle (θ_3 in four-bar terms) in the formula by mistake; always confirm you're using the crank angle θ_2 in this equation.
- *Sign Convention:* The negative sign in the equation comes from our coordinate setup (as θ_2 increases, the slider might be moving in the negative x-direction in our diagram). Don't let it confuse you – often the exam question asks for speed (magnitude) or will specify direction (like "moving to the left" or "retracting"). It's safest to compute the magnitude using the formula (you can drop the sign) and then use logic for direction (e.g., "the piston is moving upward/downward"). If a numeric answer expects a sign, define your positive direction clearly and stick to it [^sign].
- *Geometry Constraints:* Remember that the square root $\sqrt{L^2 - R^2\sin^2\theta_2}$ is real only for $|\sin\theta_2| \le L/R$. In a physical slider-crank, L is always $\ge R$ (usually quite a bit longer) so this holds for all θ_2. If $L = R$ (a special case where connecting rod equals crank length), the mechanism just barely reaches the dead-center positions with zero slack – any longer crank or smaller rod would bind. The exam won't likely give you an impossible linkage, but keep in mind that geometry sets a range on θ_2 (0°–180° for open configuration).

Equation Passport – Slider-Crank Acceleration (Relative Motion)

Name and Purpose: Slider-Crank Acceleration Equation – Determines the linear acceleration of the slider from the crank's angular motion. It accounts for both the angular acceleration of the crank (if any) and the effect of the crank's angular velocity (centripetal acceleration) on the slider's motion. This equation is

used to find how quickly the slider's speed is changing at a given crank position.

Equation (Slider Acceleration): Differentiating the velocity equation (or performing a second derivative of the position) yields the slider's acceleration. A concise form including both ω_2 and α_2 is:

$$a_B = -R\,\omega_2^2\cos\theta_2 - \frac{R^2\,\omega_2^2\cos 2\theta_2}{\sqrt{L^2 - R^2\sin^2\theta_2}} + R\,\alpha_2\sin\theta_2\,.$$

This looks a bit intimidating, but it's just the sum of three parts: a term $-R\,\omega_2^2\cos\theta_2$ from the crank's centripetal acceleration, a second term involving $\cos 2\theta_2$ that comes from the geometry constraint (the influence of the connecting rod's angle change), and a term $R\,\alpha_2\sin\theta_2$ from any angular acceleration of the crank. If the crank rotates at constant speed ($\alpha_2 = 0$), the formula reduces accordingly (drop the third term). If the crank has an angular acceleration, that third term adds or subtracts to the slider's acceleration depending on the direction of α_2.

Variables and Units:

- a_B – Slider's linear acceleration (m/s²). Positive in the defined positive direction of slider travel (same direction as for v_B). A positive a_B means the slider's velocity is increasing in the positive direction, while a negative a_B means it's decelerating or accelerating opposite to the positive direction.
- R – Crank length (m), same as above.
- L – Connecting rod length (m).
- θ_2 – Crank angle (radians).
- ω_2 – Angular velocity of the crank (rad/s).
- α_2 – Angular acceleration of the crank (rad/s²). If the crank's speed is changing, this term is nonzero. Sign convention: if ω_2 is increasing in the positive rotation direction, α_2 is positive; if the crank is slowing down, α_2 is negative. If the problem states something like "the crank speed is 10 rad/s and decreasing at 2 rad/s²," then $\omega_2 = 10$, $\alpha_2 = -2$ in our sign convention.
- *(All units should be SI-consistent: lengths in m, ω in rad/s, α in rad/s². Angles for trig functions can be in degrees as long as your calculator is in degree mode – just be careful [^units].)*

Assumptions and Scope:

- Same basic assumptions as for the velocity equation (planar mechanism, rigid links, using the open configuration solution).
- Small-angle or specific positions might simplify the formula (e.g. at $\theta_2 = 90°$, as we'll see in sanity checks). But this full form is general for any θ_2 in the allowed range.
- We assume the crank's angular acceleration α_2 is either given or zero (constant speed). The formula linearly adds that effect; if you're only dealing with constant crank speed, you can ignore the α_2 term.

Limit Tests (Sanity Checks):

- **Constant Speed (no α_2):** If the crank spins at constant speed ($\alpha_2 = 0$), the formula simplifies to $a_B = -R\,\omega_2^2\cos\theta_2 - \frac{R^2\,\omega_2^2\cos 2\theta_2}{\sqrt{L^2-R^2\sin^2\theta_2}}$. At the endpoints ($\theta_2 = 0°$ or 180°), $\cos\theta_2 = \pm 1$ and $\cos 2\theta_2 = 1$, and $\sqrt{L^2 - R^2\sin^2\theta_2} = L$ (since $\sin\theta_2 = 0$). Plugging in $\theta_2 = 0$: $a_B = -R\,\omega_2^2(1) - \frac{R^2\,\omega_2^2(1)}{L} = -R\,\omega_2^2 - \frac{R^2}{L}\omega_2^2$. This is a negative value (slider decelerating if we define outward as positive, which makes sense because at the end of travel the slider is slowing to a stop to turn around). If L is much larger than R, the second term is small and $a_B \approx -R\,\omega^2$, which is basically the centripetal deceleration component along the slider's axis when the crank is straight. At mid-stroke ($\theta_2 = 90°$), $\cos\theta_2 = 0$, $\cos 2\theta_2 = -1$, and $\sqrt{L^2 - R^2} = \sqrt{L^2 - R^2}$. The formula gives $a_B = 0 - \frac{-R^2\omega_2^2}{\sqrt{L^2-R^2}} + 0 = \frac{R^2\omega_2^2}{\sqrt{L^2-R^2}}$. This is positive, meaning the slider is accelerating in the positive direction at that instant (if we assume crank going from 0 toward 90°, the slider has picked up speed in the positive direction and is still speeding up at 90°). These checks affirm that the formula behaves reasonably in extreme positions.
- **Including Angular Acceleration:** Suppose the crank is speeding up (α_2 positive). At $\theta_2 = 0°$, the term $R\,\alpha_2\sin\theta_2$ is zero ($\sin 0 = 0$), so α_2 doesn't affect the fact that acceleration is negative (decelerating) at the end of stroke. At $\theta_2 = 90°$, $R\,\alpha_2\sin\theta_2 = R\,\alpha_2(1) = R\,\alpha_2$. If α_2 is positive, this adds to a_B – meaning if the crank is being driven faster and faster, it helps accelerate the slider more when the crank is at mid-position. If α_2 is negative (crank slowing down), it subtracts, potentially reducing or even reversing the sign of a_B at some positions. The formula will correctly capture these combined effects of kinematics and changing speed.

Use vs. Sibling Equations: There isn't a direct "sibling" formula for slider acceleration aside from differentiating the velocity expression or using general rigid body acceleration formulas. In some cases, you might use **relative acceleration equations**: for example, $\mathbf{a}_B = \mathbf{a}_A + \boldsymbol{\alpha}_2 \times \mathbf{r}_{B/A} - \omega_2^2\mathbf{r}_{B/A}$ plus components from link 3's rotation, etc. However, that vector approach essentially leads to the same result encoded in the scalar equation above. Use this direct equation for quick results when you have numeric values. If you ever mix this up with pure rotation formulas: recall that a point on a rotating crank has acceleration $r\omega^2$ towards the center plus $r\alpha$ tangential – but the slider is not on the crank; it's connected by the rod. So we must include the geometry term (that $\cos 2\theta_2$ bit) to account for how the connecting rod's angle alters the transmission of acceleration. In summary, this equation should be used for planar *slider-crank acceleration* problems instead of simpler rotating-body formulas or instead of trying to apply energy methods (work-energy is tricky here because directions change).

Common Exam Traps:

- *Missing the α term:* If the problem statement implies the crank speed is changing (e.g. "the crank's angular velocity is increasing at 5 rad/s²"), don't forget to include the $R\,\alpha_2\sin\theta_2$ term. Students sometimes compute only the centripetal part and miss the contribution of angular acceleration. A quick way to remember: α contributes like an extra "tangential acceleration" component projected onto the slider's direction (hence the sine).
- *Sign and Direction:* As with velocity, be mindful of sign. If your computation gives a negative acceleration, interpret it: a negative a_B (with our sign convention) means the slider is accelerating opposite to the positive direction (often that means it's decelerating if it was

moving positive, or accelerating in the return direction). On the exam, a question might ask "what is the magnitude of the acceleration" or might phrase it as "calculate the acceleration (indicate direction)". It's wise to state something like "$a_B = -35$ m/s^2 (decelerating, i.e. accelerating toward the left)" to be clear. The negative sign alone is not a full answer without context [^sign].

- *Calculation Complexity:* This formula is complex enough that doing it in one step on a calculator is prone to error. A trap is to plug numbers blindly into a big expression and make a parentheses or algebra mistake. **Exam tip:** break the problem down. Solve for intermediate quantities: find $\sin\theta_2$ and $\cos\theta_2$ first, maybe compute the term $\sqrt{L^2 - R^2\sin^2\theta_2}$ as an intermediate result, and then assemble the formula. This reduces chances of hitting the wrong keys [^calculator]. Remember, the exam allows scientific calculators but not computer algebra systems, so you have to be the one managing the complexity. Writing down the intermediate values neatly also helps prevent sign mistakes.

Special Notes: *Calculator usage:* When entering these equations into your FE-approved calculator (Casio fx-115, TI-36X Pro, HP 35s, etc.), use parentheses generously. For example, on a TI-36X Pro you might compute the second term by first calculating the denominator $\sqrt{L^2 - R^2\sin^2\theta_2}$ and storing it, then compute $R^2\cos2\theta_2$ divided by that, etc. Make use of the memory or the multi-line editor to avoid retyping long expressions. Always ensure your calculator is in the correct angle mode (RAD mode if you input ω in rad/s and use trig functions with θ in degrees, or input θ in radians accordingly) [^units]. A common mistake is leaving the calculator in DEG mode and plugging ω in rad/s, causing trig functions to misinterpret the angle. Double-check units and modes before finalizing your answer.

Explanation & Analysis

What is this used for? These slider-crank kinematics formulas are used to find how fast the slider is moving (velocity) or how it's accelerating at a given instant, based on the crank's motion. In practical terms, if you know how fast an engine's crankshaft is spinning and the geometry of the piston mechanism, you can find the piston speed and acceleration at each point in the cycle. For the FE Exam, problems will typically present a mechanism with a certain configuration (angles and lengths) and ask for the slider's velocity or acceleration. You might see this in questions about engines, compressors, or any linkage system where rotary motion is converted to linear motion. The formulas we've presented allow you to plug in the numbers and get the answer, but it's equally important to understand the *trends*: for instance, you should expect a slider to have zero velocity at endpoints and maximum velocity mid-stroke, or that a faster spinning crank yields proportionally faster slider motion.

Breaking down the formula: Let's dissect the velocity equation term by term to build intuition. The slider's velocity

$$v_B = -R\,\omega_2\sin\theta_2 - \frac{R^2\,\omega_2\sin\theta_2\cos\theta_2}{\sqrt{L^2 - R^2\sin^2\theta_2}}$$

has two parts:

- The first part $-R\,\omega_2\sin\theta_2$ looks a lot like the horizontal component of the crank's tip velocity. In fact, $R\,\omega_2$ would be the speed of point A (the end of the crank) moving in a circle. Multiplying by $\sin\theta_2$ gives the component of that velocity that is directed along the slider's axis (horizontal direction in our diagram). The negative sign, again, is just due to the coordinate we chose (it indicates that if θ_2 increases in the counter-clockwise direction, the slider moves in the negative x direction). Ignoring the second term for a moment, if the connecting rod were very long or even if it were a pin in a slot aligned with the crank pin, this first term would basically be the slider velocity. So this term can be thought of as "what the slider velocity would be if it were just the horizontal projection of the crank's tip velocity."
- The second part $-\frac{R^2\,\omega_2\sin\theta_2\cos\theta_2}{\sqrt{L^2-R^2\sin^2\theta_2}}$ is a correction term that accounts for the connecting rod constraint. Because link 3 imposes that the slider and crank pin stay a fixed distance L apart, the slider's motion is a bit *less* (or sometimes more) than the crank's horizontal projection, depending on angle. This term adjusts the slider speed up or down. When θ_2 is small, $\cos\theta_2$ is large and $\sin\theta_2$ is small, the correction term is small – meaning the slider's velocity is mostly just $R\omega_2\sin\theta_2$. When θ_2 is around 45°, $\sin\theta_2$ and $\cos\theta_2$ are moderate, and the correction is more significant. At $\theta_2 = 90°$, $\cos\theta_2 = 0$, so this term vanishes entirely – meaning at that position, the simple projection $R\omega_2\sin\theta_2$ (which becomes $R\omega_2$) is actually exactly the slider velocity. This makes sense: at mid-stroke, the connecting rod is perpendicular to the slider, so it doesn't constrain the horizontal motion – the crank pin is moving purely horizontally at that instant.
- If you factor $v_B = -R\omega_2\sin\theta_2\left(1 + \frac{R\cos\theta_2}{\sqrt{L^2-R^2\sin^2\theta_2}}\right)$, you see the term in parentheses is a multiplier that deviates from 1 as the geometry dictates. For exam scenarios, you can think: "slider velocity = crank tangential speed × $\sin\theta_2$ × (some geometric factor)." The geometric factor $\left(1 + \frac{R\cos\theta_2}{\sqrt{L^2-R^2\sin^2\theta_2}}\right)$ will be >1 when $\cos\theta_2$ is positive (0°–90°) and <1 when $\cos\theta_2$ is negative (90°–180°), meaning the slider moves *faster* than the crank's horizontal tip speed in the first half of the motion and *slower* in the second half (or vice versa depending on direction). This is related to the classic "non-uniform motion" of a piston – it moves faster in one half of the rotation than the other, which is known as reciprocating engine kinematics (producing a slight asymmetry between the outstroke and return stroke speeds).

For the acceleration equation, a similar breakdown can be made:

$$a_B = -R\,\omega_2^2\cos\theta_2 - \frac{R^2\,\omega_2^2\cos2\theta_2}{\sqrt{L^2 - R^2\sin^2\theta_2}} + R\,\alpha_2\sin\theta_2\,.$$

- The term $-R\,\omega_2^2\cos\theta_2$ comes from the centripetal acceleration of point A (the crank pin). Point A itself has an inward acceleration toward O_2 of magnitude $R\omega_2^2$. The horizontal component of that (pointing along the slider's line) is $R\omega_2^2\cos\theta_2$ towards the crank pivot. Depending on the crank angle, this either accelerates or decelerates the slider. For example, at $\theta_2 = 0°$, $-R\omega^2\cos\theta_2 = -R\omega^2(1)$ which is a negative acceleration (pulling the slider back toward the pivot, i.e. deceleration if slider was moving outward). At $\theta_2 = 180°$, $\cos\theta_2 = -1$, so $-R\omega^2(-1) = +R\omega^2$, which in our sign convention would be a positive acceleration (pushing the slider outward). This term is essentially telling us: whenever the crank has a component aligned with the slider (θ near 0 or 180), the

crank's rotation is trying to reverse the slider's direction (high decel/accel). When the crank is perpendicular (θ = 90°), this term is zero – the centripetal acceleration is vertical, not along the slider at all.

- The term $-\frac{R^2\,\omega_2^2\cos 2\theta_2}{\sqrt{L^2-R^2\sin^2\theta_2}}$ is the more complex part from the linkage geometry. It results from differentiating that correction term in velocity. Without diving into calculus detail, notice it involves $\cos 2\theta_2$. That means it has a period of 180° – it will be positive in one half of the motion and negative in the other. In fact, if you ignore α_2, the sum of the first two terms can be combined over a common denominator to form a single fraction (that algebra gets a bit messy, but it works out). The important thing is this second term usually has smaller magnitude than the first for moderate L, but it fine-tunes the acceleration. For instance, if L is huge, this term nearly vanishes (because the denominator is large), and then $a_B \approx -R\omega^2\cos\theta_2$ – a simple harmonic acceleration form (like a sinusoidal motion, which is what you'd expect for extremely long rod). For smaller L (like a more stubby mechanism), this term adds more deviation: it can make the peak acceleration larger or smaller than $R\omega^2$.
- The $R\,\alpha_2\,\sin\theta_2$ term is easier to interpret: it's the direct contribution of the crank's angular acceleration. If the crank is speeding up (positive α_2) and θ_2 is positive (meaning the crank's tangential acceleration has a component along the slider's direction), it pushes the slider to accelerate more. If the crank is slowing down (α_2 negative), this term will oppose the slider's motion. At θ_2 = 0 or 180, this term is zero (because any angular acceleration at those positions is perpendicular to the slider, not contributing along its path). At θ_2 = 90°, this term is maximized (sin90=1), meaning any angular acceleration of the crank has full effect on speeding up or slowing down the slider at mid-stroke.

Practical interpretation: If you're solving a problem, you don't necessarily plug into these big formulas blindly. A good strategy is:

1. **Understand the position** – Draw a quick sketch of the mechanism at the given angle. Identify where the slider is (extreme, middle, etc.). This will tell you qualitatively if the slider is moving fast or slow, and accelerating or decelerating. For example, if the crank is almost straight with the slider, you expect slider velocity near zero and a reversal (acceleration will be large, pointing back inward).

2. **Compute step-by-step** – Find $\sin\theta_2$ and $\cos\theta_2$. Compute the slider velocity using the simpler first form if possible. Check if the sign makes sense with your sketch (e.g., if your math gives a negative v but you know the slider should be moving left, that's consistent if you set right as positive).

3. **For acceleration**, if α_2 = 0, it's mostly about ω_2^2 terms. Plug those carefully. If α_2 is given, add that part. Again, check direction: if you found earlier the slider was slowing down, your acceleration should come out opposite to velocity's direction.

4. **Use the Handbook or known results** – The FE Exam Reference Handbook will have a section (as we saw) on Kinematics of Mechanisms, often listing formula relationships for four-bar linkages. It may not explicitly list the final simplified slider-crank formulas, but it gives enough info (like position equations and maybe velocity equations in component form) to derive what you need. Familiarize yourself with those entries (for example, knowing that "Kinematics of Mechanisms" section contains such formulas means you can find it quickly during the exam if needed). Our "search cues" above help you jump to those pages.

By mastering this, you're essentially learning to analyze any planar mechanism's motion. The slider-crank is just one example (albeit a very common and important one). The same principles of loop equations and differentiation apply to other linkages – like a four-bar linkage with all rotating links, or a crank-rocker mechanism (which is a four-bar where one link oscillates). In all cases, you write the geometric constraints and differentiate for velocities and accelerations.

Finally, remember that solving mechanism kinematics is as much about reasoning as it is about formulas. Use physical intuition: at extreme positions things slow down, at mid positions they speed up; shorter links cause more rapid changes, longer links smooth it out. This intuition can often help you catch a mistake – if you get a slider velocity that's higher than the crank's peripheral speed, is that plausible? (It can be, in some ranges, due to linkage amplification, but only so much). If you get an acceleration that doesn't change sign where it should, double-check. And on exam day, stay calm and methodical: as someone who's dealt with many mechanisms (and perhaps even taken apart an engine or two during my studies), I can tell you that picturing the motion in your head or on paper goes a long way to avoiding errors. Keep practicing problems, and soon this will become second nature!

[^geometry]: *Derivation Note:* The loop equation $(x - R\cos\theta_2)^2 + (R\sin\theta_2)^2 = L^2$ comes from dropping a perpendicular from point A onto the line of slider travel. x is the horizontal distance from the crank's rotation center O_2 to the slider. The difference $x - R\cos\theta_2$ is the horizontal distance from A to the slider (essentially the projection of link 3 onto the horizontal line), and $R\sin\theta_2$ is the vertical height of A above the slider. Those form the legs of a right triangle with the connecting rod as the hypotenuse L. This equation is the foundation for deriving velocities and accelerations – differentiate once for velocity, twice for acceleration.

[^units]: *Units Reminder:* Always use radians when plugging angular quantities into calculus-based formulas. In these equations, θ_2 is used inside trig functions (where you can use degrees if your calculator is set appropriately), but ω_2 and α_2 must be in rad/s and rad/s², respectively, because they are coefficients in terms that come from differentiation. For example, if the crank is given as 1000 rpm, convert that: $1000\text{ rpm} \times \frac{2\pi\text{ rad}}{1\text{ rev}} \times \frac{1\text{ min}}{60\text{ s}} = 104.72$ rad/s. Only with ω_2 in rad/s will formulas like $v = R\,\omega_2\sin\theta_2$ yield **m/s** directly. If you accidentally use ω in rpm in the formula, you're off by a factor of $2\pi/60$ which will completely throw off the answer.

[^sign]: *Sign Convention:* In our setup, we assumed a coordinate where the slider moving to the right (extending) is positive **x**. We also assumed a direction for θ_2 (typically counter-clockwise from the positive x-axis is positive θ_2). If the crank rotates CCW and pushes the slider to the left, then at that instant v_B came out negative – which is fine as long as we interpret it. The FE exam usually isn't too fussy about sign as long as you clearly indicate direction in words (e.g., "3.5 m/s to the left"). If you do include a sign, define what positive means. It's easy to inadvertently flip the sign by measuring the angle differently or taking clockwise as positive; what's important is consistency.

[^calculator]: *Calculator Tip:* When dealing with a complex expression, break it into parts. For instance, compute $N = L^2 - R^2\sin^2\theta_2$ first. Then $E = \sqrt{N}$. Then maybe $V1 = R\,\omega_2\,\sin\theta_2$ and $V2 = R^2\,\omega_2\,\sin\theta_2\cos\theta_2/E$. Finally combine $v_B = -V1 - V2$. This reduces the chance of a mistake and makes it easier to spot if an

intermediate value seems off (like if N comes out negative on your calculator, you know something's wrong with your inputs before proceeding). The allowed calculators all have the capability to do these stepwise computations efficiently.

Topic 08 - Newton's Second Law for Rigid Bodies

Topic Intro: Newton's second law for rigid bodies extends the familiar F=ma from particle mechanics to objects that can both translate and rotate. In FE Mechanical exam problems, this topic comes into play whenever a solid object (like a wheel, bar, or box) is accelerating and turning at the same time. You'll use it to determine **accelerations** or **forces** for moving bodies – for example, finding how fast a drum will spin and move when a rope pulls on it, or how quickly a car's wheel accelerates under braking. On exam day, expect questions where you must write **two equations** (one for translation, one for rotation) and solve them together. This is a core skill in dynamics problems: it shows up in typical archetypes like rolling objects on inclines, boxes tipping or sliding, and any scenario where forces cause angular acceleration. Mastering this topic means you'll confidently break down such problems into manageable equations instead of getting lost in complex motion.

K07.T08.S01 – Equations of motion for planar rigid bodies

Principle Introduction: When a rigid body moves in a plane, its motion can be split into **translation of its center of mass** and **rotation about its center of mass**. Newton's second law for rigid bodies gives us two coupled equations capturing both aspects:

- **Translational (linear) motion:** The resultant external force is equal to the mass multiplied by the acceleration of the center of mass ($\Sigma F = m\, a_G$). This extends $F = ma$ to a rigid body by focusing on the motion of the mass center G.
- **Rotational (angular) motion:** The sum of all external moments about the center of mass equals the mass moment of inertia times the angular acceleration ($\Sigma M_G = I_G\, \alpha$). This is a rotational analog to F=ma, governing how the body's rotation speeds up or slows down.
- These two equations are **simultaneous** – forces produce linear acceleration while **torques (moments)** produce angular acceleration. In general plane motion, a rigid body can do both at once. If a force doesn't act through the center of mass, it will cause **both** a_G and α (translation **and** rotation).
- We assume the mass m is constant and the body is rigid (its shape doesn't deform), so all parts of the body share the same angular acceleration α. The axis of rotation for α is perpendicular to the motion plane (think of a pin through the center coming "out of the page").
- These equations reduce to familiar cases: if the body **only translates** (no rotation), $\Sigma M_G=0$ and it behaves like a particle ($\Sigma F=ma$ only). If it **only rotates about a fixed axis through G** (no translation), then $\Sigma F=0$ and $\Sigma M_G=I_G\, \alpha$ governs the pure rotation. Most real cases are in between – hence we use both equations.

Equation Passport: Planar Rigid Body Equations of Motion – *Relates the net external force and net external moment on a rigid body to its linear and angular acceleration.*

- **Formal Equations (center-of-mass frame):**

  $\sum F = m\, a_G$
  $\sum M_G = I_G\, \alpha$

- **Variables and Units:**

  – $\sum F$ = resultant external force vector acting on the body (N in SI; lb_f in US customary)
  – m = mass of the body (kg; slug)
  – a_G = acceleration vector of the center of mass G (m/s^2; ft/s^2)
  – $\sum M_G$ = resultant moment about the center of mass ($N{\cdot}m$; $lb_f{\cdot}ft$)
  – I_G = mass moment of inertia about the center of mass ($kg{\cdot}m^2$; $slug{\cdot}ft^2$)
  – α = angular acceleration about the center of mass (rad/s^2)

- **Assumptions and Scope:**

  – **Rigid body, planar motion:** Valid for a rigid object confined to a plane (all forces and accelerations lie in that plane). The rotation axis is perpendicular to that plane (e.g. a wheel rolling on a flat surface).
  – **Constant mass & inertia:** m and I_G are constant during the motion (no mass change, no redistribution). This holds for solid objects on the FE exam (no fuel being burned off, etc.).
  – **Center-of-mass reference:** The translational equation uses acceleration of the mass center G. The rotational equation sums moments **about G** (it's simplest if you take moments around the centroid; see variations for other points).
  – **Independent equations:** The force balance and moment balance are independent equations. You need both for general motion. (In static equilibrium or particle mechanics, we sometimes ignored rotation, but not here!)
  – **Plane vs. 3D:** These formulas are for 2D plane motion. For 3D motion or rotation about arbitrary axes, additional complexity is beyond FE scope. The exam sticks to planar kinetics.

- **Limit Tests (sanity checks):**

  – *No net force → no linear acceleration:* If $\sum F=0$, then $m\, a_G=0$, so $a_G=0$. The center of mass won't accelerate (it may still move at constant velocity or stay at rest). This matches our intuition: zero net force means no change in translational motion.

  – *No net moment → no angular acceleration:* If $\sum M_G=0$, then $I_G\, \alpha=0$, so $\alpha=0$. No net torque means the body won't start spinning faster or slower; it might rotate at constant speed or not at all.

  – *Force through center → pure translation:* If the line of action of the resultant force passes through G, then it produces **no moment about G**. In that case, $\sum M_G=0$ even though $\sum F \neq 0$, so the body will **translate without rotating**. (Example: push a sled through its center – it just slides forward without turning.)

  – *Force with no net force but with a couple → pure rotation:* Conversely, you can have $\sum F=0$ but $\sum M_G \neq 0$ (for instance, two equal/opposite forces making a couple). Then $a_G=0$ but $\alpha \neq 0$: the body spins in place without its center moving.

– *Heavy or high-inertia limit:* As $m \to \infty$, a given force yields $a_G \to 0$ (an extremely heavy object barely accelerates – think pushing a building). As $I_G \to \infty$, a given moment yields $\alpha \to 0$ (very high rotational inertia resists angular acceleration – think a massive flywheel). These extremes help check unit consistency and physical sense.

Use vs. Sibling Equations: Use **these two equations** instead of the simple particle form $\sum F = m\,a$ whenever the problem involves a rigid body's rotation. In other words, apply Newton's second law in its rigid-body form when the object can spin or tip – not just slide in a straight line. If the object is effectively a point mass (no rotation), then you can revert to $\sum F = ma$ alone. On the flip side, if the object is pinned to rotate about a fixed point *other than G*, you can adapt the rotational equation by using that point (see variations on using $\sum M_P = I_P\,\alpha$). For energy or momentum problems, you might use work-energy or impulse-momentum methods instead of these force/moment equations; but when a question explicitly involves forces and accelerations at an instant, the above equations are the go-to tools.

Common Exam Traps:

– **Mixing up mass and weight:** Remember m is mass. If a problem gives you a weight (in pounds-force or newtons), you must convert it to mass to use F=m a. *For example, a 10 lbf weight corresponds to m=10/32.174 ≈ 0.311 slugs*. Forgetting this conversion (or the g_c factor in US units) is a classic mistake【1】.

– **Wrong moment point:** The rotational equation *must* sum moments about the center of mass (when used in the form $I_G\,\alpha$). If you sum moments about some other point but still use I_G, the equation is not valid unless you include an extra term. A common slip is summing moments about a convenient contact point without adjusting the inertia (see next subtopic for the correct approach). Stick to summing about G if you're going to use $I_G\,\alpha$.

– **Sign conventions:** It's easy to assign the wrong sign to forces or moments. Define a clear positive direction for translation (e.g. +x to the right) and for rotation (e.g. +M as counterclockwise). A force that tries to rotate the body clockwise should be assigned a negative moment (if counterclockwise is positive). Many avoidable errors come from sign confusion between forces and the moments they create. Tip: physically visualize which way the object will accelerate and rotate, and align your sign choices with that expectation.

– **Using the wrong I (inertia):** Make sure to use the correct mass moment of inertia for the body about its center. For example, a solid disc vs. a hoop has different I_G values【2】. Also, don't confuse mass moment of inertia (I in kg·m²) with area moment of inertia (I in m⁴ used in beam formulas) – they are different concepts. The exam handbook lists common mass moments of inertia; use the one that matches the object's geometry.

– **Acceleration of the wrong point:** a_G is the acceleration of the center of mass. If the problem asks for the acceleration of another point on the body (say a corner of a sliding box), you typically find a_G first, then relate it to that point's acceleration. Don't plug values for a point other than G directly into $\Sigma F = m\,a_G$ – that equation specifically predicts the motion of the centroid.

Exam Handbook Search Cues (Not affiliated with or endorsed by NCEES): *"plane motion rigid body", "equations of motion", "mass moment of inertia", "Newton's second law (rigid body)"* – these terms will direct you to the dynamics section showing ΣF=ma and ΣM=Iα for rigid bodies. It's useful to know where the list of **mass moment of inertia formulas** is as well (e.g. solid disk, hoop, rod about center), since you may need to grab I_G for different shapes.

Footnotes:

【1】 *Units:* In US customary units, use consistent units for F=ma. The constant $g_c = 32.174$ lbm·ft/(lbf·s²) is often used to convert weight in pounds-force to mass in slug. A safer approach is to convert weight W (lbf) to mass in slugs by m = W/32.174. In SI units, this issue doesn't arise: use newtons for force, kilograms for mass, and m/s² for acceleration.

【2】 *Common I_G values:* For a uniform solid disk or cylinder of radius R, $I_G = (1)/(2)mR^2$. For a thin hoop or shell, $I_G = mR^2$. For a rectangular flat plate about its center (axis ⊥ to plane), $I_G = (1)/(12)m(L^2 + W^2)$ for length L and width W. Knowing these helps – e.g. a hoop (large I_G) accelerates slower under the same force than a disk (smaller I_G) because more of the energy/motion goes into rotation.

Variations and Related Forms:

- **Moments about a different point:** Sometimes it is useful to take moments about a point *P* instead of the center of mass (for example, about a pivot or a point of contact). The more general form of Newton's second law for plane motion is $\sum M_P = I_G\,\alpha + m(r_{GP} \times a_G)$, which accounts for the fact that if $P \neq G$, the translation of G also creates a moment about P. A special case is a **fixed pivot**: if point P is a fixed hinge, a_G has a known relationship to α, and the extra term simplifies. In fact, you can use $\sum M_P = I_P\,\alpha$ if you compute I_P via the parallel-axis theorem ($I_P = I_G + m\,d^2$, where d is the distance from G to the pivot). This is effectively treating rotation about P directly. On the exam, if a body is pinned at a corner or rolling about a contact point, you might choose to sum moments about that point to eliminate unknown forces. Just remember to use the appropriate I for that axis (or include the $m\,r \times a$ term).

- **Translational equations in components:** The vector equation $\sum F = m a_G$ can be split into perpendicular directions (e.g. $\sum F_x = m a_{G_x}$, $\sum F_y = m a_{G_y}$). In many exam problems, you'll align one axis with the motion (say, x along an incline or horizontal surface) to simplify the force sum. The other perpendicular direction (like the normal direction) often sums to zero acceleration (no motion that way) and can be used to find a normal force or a friction force if needed.

- **Rotational axis not through center:** If a rigid body rotates about a **fixed axis that is not through G** (like a pendulum swinging about a pin at one end), you can either (a) use the general form by summing moments about G with the extra $m\,r \times a$ term, or (b) directly use $\sum M_{pivot} = I_{pivot}\,\alpha$. Method (b) is usually easier: just be sure to compute I_{pivot} for that axis (again via parallel-axis theorem). For example, a rod of length L hinged at one end has $I_{end} = I_G + m((L)/(2))^2 = (1)/(3)mL^2$. Using that in $\sum M_{end}=I_{end}\alpha$ avoids having to consider the reaction force at the hinge in the moment equation.

- **Static equilibrium as a special case:** If the accelerations are zero (a_G=0, α=0), these equations reduce to $\sum F = 0$ and $\sum M_G = 0$, which are the familiar equilibrium conditions from statics. It's worth noting because some exam problems might start in equilibrium and then "something happens" (brakes release, force is applied, etc.) causing acceleration. In analyzing those, you might first use statics to find some forces, then switch to dynamics with

ΣF=ma. Recognize that Newton's second law is basically "unbalanced forces cause acceleration" – if forces are balanced, acceleration is zero.

K07.T08.S02 – Dynamics of rigid bodies in plane motion (combined translation + rotation)

Principle Introduction: In plane motion, a rigid body often **translates and rotates at the same time**. This combined motion means that both of Newton's equations from subtopic S01 are active. To analyze such a situation, you typically need to solve **both** $\Sigma F = m\, a_G$ and $\Sigma M = I_G\, \alpha$ together, because the unknowns in one may depend on the other. Here are key considerations for combined translation+rotation problems:

- **Free-body diagram & two equations:** Start by drawing a clear free-body diagram (FBD) of the object, showing all external forces. You will write a $\Sigma F = m\, a$ equation (often along the direction of motion) and a $\Sigma M = I\, \alpha$ equation (often about the center of mass or a convenient point). Because the body moves and spins, neither equation alone is sufficient – they work in tandem to describe the motion.
- **Kinematic link (no-slip condition):** If the object is **rolling without slipping** on a surface (common in wheel and drum problems), there is a geometric constraint relating linear and angular motion: the center-of-mass acceleration a_G is related to the angular acceleration α by $a_G = \alpha R$, where R is the radius (or the distance to the point of contact). This comes from the fact that the point in contact with the ground is momentarily at rest (no slip) 【3】. You will use this relation to couple the translational and rotational equations, effectively providing a third equation when needed.
- **Solving simultaneous unknowns:** Typically, you might have two unknowns – e.g. the linear acceleration a_G and the friction force f – and two equations (ΣF and ΣM). In rolling cases, sometimes three unknowns (a_G, α, and f) appear, but the no-slip relation $a_G = \alpha R$ gives the third equation to solve them. The general strategy is to use algebra or substitution to eliminate one unknown at a time. (Many FE problems are set up so things cancel nicely if you apply the equations correctly.)
- **Choosing moment center wisely:** While $\Sigma M_G = I_G\, \alpha$ is always valid, you are free to sum moments about any point. A clever choice can simplify the math. For example, summing moments about the instantaneous contact point of a rolling wheel can eliminate the friction force from the moment equation (since the friction force passes through that point, moment = 0). The trade-off is you then must use the *parallel-axis theorem* for the inertia about that point. It's an optional trick – if it confuses you, sticking with G is fine, just solve the two original equations with the friction included.
- **Common scenarios:** Be familiar with archetypal problems like a **cylinder rolling down an incline**, a **wheel being accelerated by a force or brake**, or a **box that both slides and rotates** (like tipping). In all cases, break the motion into translation of G and rotation about G. Apply $\Sigma F = ma$ along the line of motion of G (e.g. down the slope or horizontal) and $\Sigma M = I\, \alpha$ about G (or another convenient axis). Then look for relationships (like no-slip or geometry) that connect a and α. Combined motion problems in the FE exam are essentially accounting exercises – accounting for how force splits into accelerating mass vs. accelerating rotation.

Equation Passport: Rolling Without Slipping – *Kinematic constraint relating linear and angular motion for a body rolling on a surface without slipping.*

Definition & Purpose: When a round object rolls without slipping, its translational speed and acceleration are linked to its rotational speed and acceleration. This makes the contact point with the ground momentarily at rest (no slipping). It's used to tie a_G and α together in problems involving rolling motion.

Equation (no-slip constraint):
$v_G = \omega R$, $a_G = \alpha R$,
where the directions are such that the linear velocity/acceleration of G is consistent with the rotation (typically, a_G points in the direction the object rolls, and α is in the direction that brings the contact point to rest).

Variables:
– v_G = velocity of the center of mass (m/s)
– ω = angular velocity about the center (rad/s)
– a_G = acceleration of the center of mass (m/s²)
– α = angular acceleration about the center (rad/s²)
– R = radius of the rolling object (m). *(If the object is not a simple disk, R is the distance from the center to the contact surface – e.g. for a wheel of radius R, just R; for a sphere, also its radius.)*

Assumptions:

– **No slipping:** The condition assumes static friction is sufficient to prevent relative motion at the contact point. The surface and wheel do not slide against each other.

– **Rolling on a fixed surface:** The surface itself is not moving or accelerating. (If two objects roll together or a surface moves, a similar relation can be written between their relative motion, but the basic idea holds.)

– **Pure rotation about center:** The object rotates about its own center of mass. (If an object were rolling but also oscillating or something, this simple form might not hold, but such scenarios are beyond exam scope.)

– **Instantaneous relationship:** $a_G = \alpha R$ applies at any given moment for rolling motion. If angular acceleration is not constant, it still holds instantaneously (and you could integrate it if needed). In most exam problems, α is either constant or zero.

Limitations & Endpoints:

– *Slipping case:* If static friction is overcome (e.g. if the incline is too steep or surface too slick), this equation no longer holds. Instead, a_G and α become independent, related only through friction's kinetic behavior (usually requiring energy or relative acceleration methods). The exam will typically *state* "rolls without slipping" to assure you this constraint is valid.

– *Zero radius (conceptual):* As $R \to 0$, the difference between translation and rotation vanishes – a point object can't roll. In the equation, $R \to 0$ would force $a_G \to 0$ for any finite α, which is consistent: a tiny wheel spinning in place doesn't translate much. On the flip side, if $\alpha = 0$ (no rotation), the equation gives $a_G = 0$, meaning the object can't move without rolling – true for a scenario where an object is "stuck" without slip (though in reality, if no rotation it means it's not rolling at all).

– *Direction matters:* The equations $v_G = \omega R$ and $a_G = \alpha R$ are often used in magnitude form. Be careful with signs: if you treat uphill as positive for a_G, then α should be negative for a clockwise rotation (for instance) to satisfy $a_G = \alpha R$ vectorially. In other words, the direction of a_G corresponds to the sense of rotation. A common sign mistake is forgetting to assign a negative sign to α when the rotation is clockwise under the chosen convention.

Use vs. Alternatives: Use this no-slip equation **in addition** to Newton's second law equations when a problem involves a rolling constraint. It effectively replaces the need to consider relative motion at the contact point explicitly. Without it (in a slipping scenario), you'd have to treat the friction force as unknown and perhaps use energy methods to relate a_G and α. If the problem does not involve rolling or explicitly allows slipping, do **not** apply this relation. For pure sliding (no rotation), obviously $a_G = \alpha R$ isn't used at all (since α=0 or R=0 conceptually). If the body is rolling with slipping (rare in exam, but say a car skidding out while wheels spin), you have $a_G \neq \alpha R$ and would need additional info (like a friction law or energy loss) to connect a_G and α. In summary, **use $a_G = \alpha R$ whenever "rolling without slip" is stated** – it's a powerful shortcut equation that turns a tough coupled problem into a simpler one.

Common Exam Pitfalls:

– **Forgetting the constraint:** Some students write $\Sigma F = m a$ and $\Sigma M = I \alpha$ and attempt to solve three unknowns with two equations. If you see terms like a and α together for a rolling body, remember the missing third equation is likely $a = \alpha R$. It's provided by physics, not always explicitly stated in the problem – you're expected to know it.

– **Using the constraint when it doesn't apply:** If a problem implies or states that slipping occurs (or gives a friction coefficient and asks if it will roll or slide), be cautious. If it's actually slipping, a will not equal α R. A subtle clue is energy loss: rolling without slip is pure – kinetic energy goes into translation + rotation. If mechanical energy seems "lost" beyond that, slipping or skidding might be happening. Generally, if the problem gives a static friction coefficient and asks for an acceleration, it's testing whether you know to check $F_{friction,max} = \mu_s N$ against the required friction for no-slip. Don't blindly apply a=α R if the no-slip condition fails.

– **Sign and direction errors:** As mentioned, assign a consistent sign convention. For example, on an incline, you might choose down-slope as positive for a_G and clockwise as positive for α (since rolling down an incline produces clockwise rotation in our figure). Then in $a_G = \alpha R$, one of these would actually enter with a negative sign if your conventions don't match the actual physics. An easier method: work with magnitudes and intuitively apply directions (e.g. "the wheel accelerates down the slope and spins clockwise"), then insert the proper signs when plugging into force and moment equations.

– **Using radius vs. diameter:** It sounds trivial, but under exam pressure some confuse R vs diameter. The relation uses the **radius**. If a wheel's diameter is given, remember to halve it for R. If you accidentally use the full diameter in a = α D, you'll be off by a factor of 2. Always double-check you're using radius in rotational formulas (the exam handbook's formulas for I likewise use radius, not diameter).

Exam Handbook Search Cues (Not affiliated with or endorsed by NCEES): *"rolling motion", "instantaneous center of rotation", "static friction (no slip)"*. The handbook might not spell out "no slipping" explicitly, but it covers rolling motion concepts (e.g., instantaneous center of zero velocity for rolling contact). Key references include the dynamics section on rigid body kinetics and possibly the kinematics section that states $v_{contact}=0$ for rolling without slipping. Also, remember to look up the formulas for **mass moment of inertia** for the shape in question, as you'll need I_G to solve these problems.

Analysis & Application: Let's walk through how you'd handle a typical combined motion problem step by step – using the rolling wheel on an incline as an example:

1. **Free-Body Diagram:** Sketch the rigid body and mark all forces. For the incline example, draw weight W=mg acting at the center (straight down), the normal force N at the contact point (perpendicular to surface), and friction f at the contact (tangent to surface, opposing slipping). Clearly indicate the center of mass G and choose a coordinate axis (e.g. x axis along the incline, y axis perpendicular). Also decide a sign convention for rotation (e.g. + for counterclockwise). This step sets up your equations – get the directions right! *Pro-tip: mentally visualize which way G will accelerate (down the slope) and which way the object will rotate (clockwise); use that to guide your axis and sign choices.*

2. **Apply Σ F = m a (Translation):** Write separate equations for the force components. Along the incline (x-direction), sum the forces: $m a_G = mg\sin\theta - f$ (taking down-slope as positive, so gravity's component $mg\sin\theta$ is positive and friction f is negative since it points up-slope). Perpendicular to the incline (y-direction), you'd have $m a_{G,y} = 0 = N - mg\cos\theta$ (no acceleration perpendicular, so this just gives $N = mg\cos\theta$ – often used to find friction's maximum if needed). The main dynamic equation here is the one along the slope: it relates f and a_G. At this point, you have one equation with two unknowns (a_G and f) – not enough by itself, which is expected for a rolling problem.

3. **Apply Σ M = I α (Rotation):** Choose a point for taking moments. A convenient choice is often the center G (since our equation is $\Sigma M_G = I_G \alpha$). Sum the moments of all forces about G. In the incline example, weight and normal both pass through G or the contact, respectively – draw their lines of action to see their moment arms about G. Weight goes through G (no moment about G). For a circular wheel, both weight and the normal force pass through G, so their moments about $G$are zero. The only torque about $G$is from friction (moment arm = R, perpendicular force component $N sin\theta$), but you can avoid that complexity by instead summing moments about the contact point P. Let's do it about G first: Taking clockwise as positive (since we expect clockwise rotation), the friction force f at the contact has a lever arm R (the radius) and tends to produce clockwise rotation (assuming f points up the plane). So $\sum M_G = f \cdot R$ (clockwise). Set this equal to $I_G \alpha$:
   $f R = I_G \alpha$.
   This rotational equation introduces α and relates it to f. Now we have two equations: (i) $mg\sin\theta - f = m a_G$ and (ii) $fR = I_G \alpha$. Still three unknowns (a_G, α, and f) – so **enter the no-slip relation**.

4. **Invoke No-Slip Relation (if applicable):** For rolling without slipping, use $a_G = \alpha R$. This third equation connects the linear and angular accelerations. Now

substitute $\alpha = a_G/R$ into the moment equation (ii): $fR = I_G (a_G/R)$. Simplify that: $fR = (I_G)/(R)\, a_G$, so $f = (I_G)/(R^2)\, a_G$. This expresses f in terms of a_G. You can plug this into the force equation (i) to eliminate f.

5. **Solve for the acceleration:** Substituting f gives $mg\sin\theta - (I_G)/(R^2)a_G = m\, a_G$. Now solve for a_G:
$mg\sin\theta = m\, a_G + (I_G)/(R^2)a_G = a_G(m + (I_G)/(R^2))$.
So, $a_G = (mg\sin\theta)/(m + (I_G)/(R^2))$. This formula is illuminating: the denominator $m + (I_G)/(R^2)$ is larger than m alone, meaning $a_G < g\sin\theta$. In plain English, the object accelerates more slowly than it would if it were just sliding with no rotation ($g \sin\theta$ is the acceleration of a frictionless sliding block). The difference $(I_G)/(R^2)$ effectively adds "virtual mass" due to needing to spin up the rotational inertia. If I_G is bigger (more rotational inertia), a_G is smaller – which matches physical intuition.

6. **Find other quantities as needed:** Once you have a_G, you can find α from $\alpha = a_G/R$, and the friction force from $f = m\, g \sin\theta - m\, a_G$ (or directly $f = (I_G)/(R^2)a_G$ from earlier). You might check that f does not exceed μ_s N to ensure no slip – the exam could ask that. In our example formula, if θ is too steep, the required f might come out larger than μ_s N, indicating the no-slip assumption fails (and the object would actually skid). But assuming it doesn't, you have fully determined the motion.

7. **Double-check units and sense:** Verify that your computed a_G has correct units (m/s^2 or ft/s^2). Everything in our formula had units: $mg\sin\theta$ (N) divided by $(m + I_G/R^2)$ where I_G/R^2 has units of mass, so the result is in $N/(kg) = m/s^2$, good. Check extreme cases: if $I_G = 0$ (say a point mass on a frictioned incline, practically impossible but theoretically), then $a_G = g\sin\theta$ – it slides with no rotational inertia to worry about, makes sense. If I_G is huge (the object is like a massive flywheel), a_G approaches 0 – it hardly moves. The direction: we assumed down-slope as positive and got a positive a_G, so indeed it accelerates down the slope as expected. If we had gotten a negative number, it would mean our assumed direction was opposite (e.g. maybe an uphill acceleration if something was pulling it up faster than gravity, not in this case). Always interpret the sign of your answer relative to your assumptions. Finally, ensure the friction direction made sense: we found f positive in our sign convention (meaning friction acts up-slope). That aligns with preventing slip (it must oppose the would-be slipping direction, which was down-slope). Consistency checks like this are a good habit.

By following these steps – FBD, ΣF, ΣM, relate a and α, solve algebraically – you can tackle any planar rigid body dynamics problem on the FE exam. Practice a few scenarios (rolling objects, pulley systems with drum inertia, carts with wheels, etc.) to cement the procedure. It's all about systematic application of Newton's second law in its two forms, plus any needed kinematic constraints.

Special Notes: On the exam, you'll often use a calculator just for basic arithmetic in these problems – the heavy lifting is in setting up equations correctly. The Casio, TI, or HP calculators approved for the FE can all handle solving two linear equations, but honestly, it's usually just as fast to do substitution manually. If you do use the solver function, be careful to input the equations correctly with consistent units. Also remember that angles should be in radians if you directly use them in α or ω calculations (for example, converting a rotational speed in rpm to rad/s before using $v = \omega R$). Most of the time, though, the problems are algebraic and you won't be plugging trigonometric functions into the α formulas. Finally, **don't round too early** – carry sufficient precision for intermediate steps (especially when computing I_G or converting units) to avoid making a rounding error that leads to an answer slightly off the multiple-choice options.

Topic 09 - Work–Energy of Rigid Bodies

Topic Intro: In the FE Mechanical Exam, rigid-body work–energy methods provide a powerful shortcut for solving dynamics problems involving both translation and rotation. This topic addresses how to calculate a rigid body's kinetic energy and how to apply the work–energy principle to find velocities, displacements, or required work. It matters on exam day because work–energy questions often bypass complicated force/acceleration calculations by using energy conservation (when applicable) or energy balance with non-conservative work. A typical question might give a rolling cart or rotating arm with forces acting, then ask for the object's speed after moving a certain distance or angle. By using work–energy of rigid bodies, you can solve such problems systematically: compute initial kinetic energy, add work done by all forces and moments (including weight, springs, friction, and applied torques), and equate it to final kinetic energy. This method is especially handy for combined translation–rotation scenarios (e.g. a wheel with both linear and angular motion) where directly applying Newton's second law can be unwieldy. In summary, **work–energy of rigid bodies** is all about relating the energy changes of a moving body to the work done on it – a strategy that can save you time and reduce mistakes under exam pressure.

K07.T09.S01 – Kinetic Energy of a Rigid Body in Plane Motion

Principle Introduction: A rigid body in plane motion (moving in 2D, possibly rotating) possesses kinetic energy from two sources: the translation of its center of mass and the rotation about its center of mass. Key points to build intuition include:

- *Translational KE:* If the entire mass m moves with the center of mass velocity v_c, it contributes kinetic energy $\frac{1}{2}mv_c^2$. This term treats the rigid body **as if all its mass were concentrated at the center of mass** moving at speed v_c.
- *Rotational KE:* Any rotation about the center of mass adds kinetic energy $\frac{1}{2}I_c\omega^2$, where I_c is the mass moment of inertia about the center of mass and ω is the angular speed. This term accounts for the body's internal energy due to spinning.
- *Combined Motion:* For general planar motion, **total kinetic energy is the sum** of translational and rotational parts. Even if an object both moves and spins (like a rolling wheel or a moving robot arm), you can calculate its energy by adding these two contributions.
- *Center of Mass Reference:* Importantly, v_c should be measured in an inertial frame (ground frame) for this formula. The moment of inertia I_c must be about the center of mass; if you only know inertia about another point, use the parallel-axis theorem to get I_c before computing rotational KE.
- *Units & Magnitude:* Kinetic energy is measured in joules (J) in SI units. Translational and rotational KE will each be in J, so their sum is too. Numerically, rotational energy can be significant if ω is high or I_c is large (e.g. flywheels), whereas a light object with modest spin might have most of its energy in translation. Always include both terms if the problem involves rotation – leaving one out is a common mistake.

Equation Passport: Kinetic Energy (Rigid Body in Planar Motion)

Name and purpose: *Planar Rigid-Body Kinetic Energy – computes the total kinetic energy of a rigid object that may be translating and rotating in a plane.*

Equation:

$$T = \frac{1}{2}\, m\, v_c^2 + \frac{1}{2}\, I_c\, \omega^2$$

where the first term is translational KE of the center of mass, and the second term is rotational KE about the center of mass.

Variables and units:

- T: total kinetic energy of the rigid body, in joules (J) or N·m (SI units).
- m: mass of the rigid body, in kilograms (kg).
- v_c: speed of the center of mass, in m/s (magnitude of the velocity of the COM). If the center of mass has components v_{cx} and v_{cy}, then $v_c = \sqrt{v_{cx}^2 + v_{cy}^2}$.
- I_c: mass moment of inertia about the center of mass, in kg·m^2. (Sometimes denoted I_G in texts, with G indicating centroidal axis.)
- ω: angular velocity of the rigid body about its center of mass, in radians per second (rad/s). *(Use radians in all energy formulas; if ω is given in RPM or degrees per second, convert to rad/s.)*

Assumptions and scope:

- **Planar motion:** The formula assumes the rigid body's motion is confined to a plane (no tumbling in 3D). The body may translate in any direction in that plane and rotate about an axis perpendicular to the plane (usually the z-axis out of plane).

- **Rigid body:** The object is rigid (non-deforming), so its mass distribution is fixed and I_c remains constant.

- **Reference at center of mass:** I_c and v_c are measured about the center of mass. If you prefer to compute kinetic energy about another point or axis, you must account for motion relative to that point. (For example, if a body is purely rotating about a fixed point O on the body, you could alternatively use $T = \frac{1}{2}I_O\omega^2$, where I_O is the moment of inertia about that fixed point. In general, however, using the center of mass formula is the safest approach.)

- **Additivity:** Translational and rotational energies add linearly. There is no cross term as long as v_c is the velocity of the center of mass and I_c corresponds to the same point.

Limit tests (sanity checks):

- If $\omega = 0$ (the body is not rotating at all), the formula reduces to $T = \frac{1}{2}mv_c^2$. That makes sense: all the energy is purely translational if there's no spin.

- If $v_c = 0$ (the center of mass is stationary, e.g. the body is just spinning in place about its center), the formula reduces to $T = \frac{1}{2} I_c \omega^2$. All energy is then purely rotational, as expected.
- If both v_c and ω are zero, $T = 0$ (no motion, no kinetic energy), which is consistent.

Use vs. sibling equations: Use this rigid-body KE formula instead of the simpler particle formula ($\frac{1}{2}\mathrm{mv}^2$) whenever the object can rotate. In contrast to a point-mass or particle, a rigid body's energy isn't fully captured by one velocity term – you must account for rotation. Also use this in place of the full system energy formula if no potential energies are involved; it focuses just on kinetic energy of a single body.

Common exam traps:

- **Forgetting rotational energy:** A very common mistake on the FE exam is to treat a moving rigid body as just a particle and use $T = \frac{1}{2} m v^2$, neglecting the $\frac{1}{2} I_c \omega^2$ term. If the object is rotating (like wheels, gears, pulleys, or anything spinning), failing to include rotational kinetic energy will lead to wrong answers. Always ask: is there rotation? If yes, include $I\omega^2/2$.

- **Using the wrong I (moment of inertia):** Make sure you use the moment of inertia about the center of mass for this formula. If the problem only provides I about some other axis (say about a hinge or about a geometric axis not through COM), convert it to I_c using the parallel-axis theorem [^1]. Using a moment of inertia about a different point in $T = \frac{1}{2} I \omega^2$ without adjustment will miscalculate the rotational energy.

- **Mixing units (especially in US Customary units):** In SI units, $T = \frac{1}{2} m v^2$ is straightforward (Joules = kg·m²/s²). In US units, remember that m is in slug or lbm (pound-mass) and v in ft/s, so $\frac{1}{2} m v^2$ gives energy in ft·$\mathrm{lb_m}$, *not* the usual ft·lbf for work/energy. To get work/energy in ft·lbf, you must divide by the conversion factor $g_c = 32.174$ lbm·ft/(lbf·s^2). [^2]. Forgetting g_c when using US units will cause a factor of 32.174 error. (On the exam, if you stick to using weights in lbf and mass via $W = mg$, you implicitly take care of this, but be cautious if using m in slug/lbm directly in formulas.)

- **Not using radians for ω:** When computing $\frac{1}{2} I \omega^2$, ω must be in rad/s. If an angular speed is given in, say, $60°/\mathrm{s}$, convert to 1.047 rad/s before plugging in. Using degrees per second in the formula numerically will undercount energy (since 1 deg/s is 0.01745 rad/s).

Exam Handbook Search Cues (Not affiliated with or endorsed by NCEES): *kinetic energy, rigid body kinetic energy, translational KE, rotational KE, moment of inertia*

Footnotes:

[^1]: *Parallel-axis theorem:* $I_c = I_O - md^2$, or more commonly $I_O = I_c + md^2$. If you know the moment of inertia about a parallel axis O a distance d from the center of mass, subtract md^2 to get I_c. Always ensure you're using the correct axis for energy calculations.

[^2]: In many texts, kinetic energy in USCS units is given by $KE = \frac{mv^2}{2g_c}$ to directly yield ft·lbf. Here $g_c = 32.174$ lbm·ft/(lbf·s^2) is the unit conversion factor between pound-mass and pound-force. Remember this adjustment if working in imperial units on exam problems.

K07.T09.S02 – Work–Energy Principle Applied to Rigid Bodies

Principle Introduction: For rigid bodies, the work–energy principle says that the net work done by all external forces and moments equals the change in the body's kinetic energy. In practical terms:

- *Start and end energy:* Identify the body's kinetic energy at the initial state (1) and at the final state (2). This includes both translation and rotation (use the formula from S01 for each state as needed).
- *Work by forces:* Compute the work done by each force acting on the body as it moves from state 1 to 2. This includes applied pushes or pulls (force F times displacement in the direction of F), weight (force $W = mg$ times vertical drop height), normal or support forces (which typically do no work if perpendicular to motion), friction forces (friction does negative work equal to friction force times distance slid), and spring forces (which do work equal to the negative change in spring potential energy).
- *Work by moments (torques):* Compute the work done by any couple moments or torques acting on the body. For a constant torque M, work = $M\Delta\theta$. If the moment varies, integrate $\int M\, d\theta$. Don't forget this term if there's a motor or brake applying a moment directly to the body's rotation.
- *Non-conservative vs conservative forces:* It's helpful to distinguish forces that **conserve mechanical energy** (gravity, springs) from those that dissipate or input energy (friction, thrust, brake torques). Conservative forces can be handled by using potential energy change instead of explicit work, but either way, they fit into the same equation. On the FE exam, you can either include weight's work as $+W\Delta y$ (with sign careful for direction) or include mgh as potential energy change; the algebraic result is the same if done correctly.
- *Equation form:* Sum up *all* the work contributions and set that equal to the change in kinetic energy: **Work (total) =** $T_2 - T_1$. By convention, if the work is done *on* the body (adding energy), it's positive; if the body does work against something (losing energy), that work term is negative. The golden rule is energy accounting: *Initial KE + Work input – Work dissipated = Final KE*. Keep track of signs and you'll solve these problems reliably.

Equation Passport: Work–Energy Equation for a Rigid Body
Name and purpose: *Work–Energy Principle – relates the net work done on a rigid body to the change in its kinetic energy.*

Equation:

$$T_1 + \sum U_{1\to 2} = T_2,$$

which can be rearranged as $\sum U_{1\to 2} = T_2 - T_1 = \Delta T$. In words: the work done by all forces and moments as the body moves from state 1 to state 2 equals the increase in the body's kinetic energy.

Variables and terms:

- T_1: kinetic energy of the rigid body at the initial state 1 (Joules).
- T_2: kinetic energy at the final state 2 (Joules).
- $\sum U_{1\to 2}$: sum of work done by all external forces and couple

moments during the motion from state 1 to 2 (Joules). This includes:

- Work by **applied forces:** For each force F, $U = Fs\cos\phi$ (constant F case) where s is the displacement along the line of action and ϕ is angle between force and displacement. If force varies, $U = \int \mathbf{F} \cdot d\mathbf{r}$.

- Work by **weight (gravity):** $U_W = W\,(-\Delta y)$ if we take upward as positive energy (weight does positive work when an object moves downward, converting potential to kinetic). Equivalently, $U_W = +mg\Delta h$ if Δh is the drop in height (taking that as positive). Be careful with sign: if the object gains altitude, gravity's work is negative (taking energy out).

- Work by **spring forces:** $U_k = \frac{1}{2}k(x_1^2 - x_2^2)$, which is actually *negative* of the change in spring potential energy. If a spring is compressed (shortens) from state 1 to 2, it does positive work on the body (releasing stored energy). If it is stretched further, it absorbs energy (negative work done on body).

- Work by **friction:** $U_f = -f_k N\, s$ for kinetic friction (force opposite to motion times distance, yielding negative work since friction removes energy and dissipates it as heat). Static friction does no work unless there is slipping.

- Work by **moments (torques):** $U_M = \int_{\theta_1}^{\theta_2} M\ d\theta$ for a moment M acting through an angular displacement. If M is constant, this simplifies to $M(\theta_2 - \theta_1)$. A clockwise moment doing clockwise rotation produces positive work (adds KE); if it opposes the rotation, it does negative work.

Assumptions and scope:

- This principle is **general for rigid body mechanics** – it doesn't require constant forces or steady motion, only that you can define initial and final states and account for work done in between. It is applicable even if forces or accelerations are changing in time, as long as you integrate their work.

- The equation as stated assumes a **single rigid body** (or a system treated as one body). If multiple bodies are involved (e.g. two connected bodies), you can write a work-energy equation for the system as a whole (summing all their KE and all external work on the system). Internal forces between parts of a system (like tension in a rope between two masses) usually cancel out or do no net work if you include all parts.

- All energy is accounted as **kinetic** here; if you prefer, you can incorporate potential energy changes on the left side as negative work by conservative forces, which effectively gives you the more familiar form $T_1 + V_1 + \text{Work}_{nc} = T_2 + V_2$ (conservation of mechanical energy plus non-conservative work). But on the FE, it's often safer to just do work directly, especially for forces like friction or applied pushes.

- **No energy losses unaccounted:** This method assumes you include *all* forms of work. If a problem mentions energy losses (e.g. "20 J lost to air resistance"), treat that as negative work in the sum. If you miss a work term, the equation won't balance.

Limit tests (sanity checks):

- If no external work is done ($\sum U = 0$), the equation reduces to $T_1 = T_2$. That means kinetic energy is conserved – consistent with an isolated system (only conservative forces where any energy might just swap between kinetic and potential).
- If the kinetic energy increases ($T_2 > T_1$), $\sum U$ comes out positive, meaning net work was done *on* the body. Conversely, if the body slows down ($T_2 < T_1$), $\sum U$ is negative – the body did work on something else (e.g. work against friction or lifting something). This aligns with the idea of work being energy transfer.

- As a special check: imagine a block of mass m sliding on a frictionless surface with a force F pushing it through distance s. Starting from rest ($T_1 = 0$), the work is Fs (assuming force parallel to motion), so $0 + Fs = T_2$. Thus $T_2 = Fs$. Since $T_2 = \frac{1}{2}mv^2$, we get $\frac{1}{2}mv^2 = Fs$. Solve for v: $v = \sqrt{\frac{2Fs}{m}}$. This matches what we'd get from kinematics ($a = F/m$, then $v^2 = 2as$). The work–energy equation produced the same result, validating the method.

Use vs. sibling methods: Use the work–energy principle as an alternative to directly applying Newton's Second Law or $\mathrm{F = ma}$ and integration, especially when dealing with displacements and speeds. It is particularly useful when forces are not constant or when dealing with combined translation and rotation (where writing $\mathrm{F = ma}$ and $\mathrm{M = I\alpha}$ and solving can be complex). If a problem asks for a velocity given distance or asks for work or energy directly, work–energy is the natural method. On the other hand, if you need time-dependent information or instantaneous forces, impulse-momentum or $\mathrm{F = ma}$ might be more direct – but those often are not required for FE exam problems.

Common exam traps:

- **Sign errors in work terms:** Pay close attention to whether each force adds energy or removes energy. For example, if a weight is lifting the body *upward*, gravity is doing negative work (taking energy out) – a very common point of confusion. A good practice is to define a clear sign convention: e.g. treat work *input to the system* as positive. Then forces that oppose motion or slow the body (friction, drag, going uphill against gravity) will naturally come in as negative work. Double-check signs for each term before solving the equation.

- **Forgetting a force or moment's work:** List all forces/moments acting on the body and evaluate each one's work. It's easy to forget that a *couple moment* (pure torque) does work as well – students sometimes omit rotational work. For instance, if a motor applies torque to spin up a flywheel, that motor's work ($M\Delta\theta$) must be included to equate to the flywheel's increased $I\omega^2/2$. On exam problems, if a rotational driver or brake is mentioned, include $M\theta$ for its work.

- **Mixing frames or reference:** Ensure displacements correspond to the same reference frame as the forces. For example, if a box is sliding on a moving conveyor, the work done by friction should be considered with respect to the distance the box slides relative to the conveyor belt, not absolute ground – otherwise you might miscalculate work. Generally, stick to an inertial frame for energy: kinetic energies measured in ground frame and work by forces measured by their movement relative to ground or the body. If you use a non-inertial frame, additional "work" terms (pseudo-forces) might appear – avoid that on the FE; keep it simple.

- **Not updating kinetic energy properly**: If the problem has multiple stages (like first the body rolls without slipping, then it

slides), you might need to apply work–energy in pieces. But typically, FE problems are one-step from initial to final. Still, be cautious to use the correct final kinetic energy: include both translation and rotation at state 2. A mistake would be computing work correctly but then setting it equal to only $\frac{1}{2}mv^2$ and forgetting $\frac{1}{2}I\omega^2$ at final state. Always recompute kinetic energy at final state with all components of motion.

- Using work–energy when not applicable: While powerful, work–energy can't directly give you information about time or instantaneous forces. If a question asks for something like acceleration at a specific instant or a reaction force during motion, energy methods alone won't provide it (you might need equilibrium or impulse-momentum concepts). However, those cases are rare for "work–energy of rigid bodies" questions – they usually stick to speeds, heights, distances, and energy, where this method shines.

Exam Handbook Search Cues (Not affiliated with or endorsed by NCEES): *work energy, kinetic energy change, work of forces, work of moment, energy conservation*

Footnotes:

- *Conservative forces and potential energy:* You have the option to move any work of weight or springs to the other side as potential energy changes. For example, $T_1 + V_1 + \text{work}_{nc} = T_2 + V_2$ is an equivalent statement, where V is gravitational + spring potential energy. The exam handbook might list the conservation of energy equation in that form. Just remember that whether you include mgh terms as V or as work $W\Delta y$ on the left, it's the same physics. Choose the approach that you are less likely to mess up signs with.

- *Work with multiple bodies:* If a problem involves, say, a pulley and block, you can write a single work–energy equation that includes kinetic energy of both the pulley (rotational) and the block (translational), and includes work done by gravity on the block. Internal forces (tension in rope) don't show up because the work done by tension on the block is canceled by work done *by* the block on the pulley (one positive, one negative). The work–energy principle can elegantly handle such connected systems if you include all parts of the system in T_1, T_2 and all external work.

- *Power and energy:* Remember that power is the time rate of doing work ($P = dU/dt$). While this subtopic doesn't focus on power, it's related: sometimes a problem might give power output of a motor and ask for work done over a time, which you can then plug into the work–energy equation. Keep units straight: 1 watt of power over 1 second delivers 1 joule of work.

K07.T09.S03 – Work–Energy in Pure Rotation (Work of a Moment)

Principle Introduction: This subtopic zooms in on the rotational aspect of work–energy: the work done by a constant moment (torque) and how it relates to rotational kinetic energy change. When a rigid body rotates about a fixed axis (or about its center of mass) under the action of a torque, you can treat the rotational motion similarly to linear motion by using the *rotational work–energy* concept:

- *Work of a moment:* A **constant torque M acting through an angular displacement** $\Delta\theta$ does work $U = M\,\Delta\theta$. This is the rotational analog of $W = F\,d$ for linear motion (force times distance). If the torque is not constant, you'd integrate: $U = \int_{\theta_1}^{\theta_2} M\,(\theta)\,d\theta$ – but many FE problems use a constant or average value for simplicity.
- *Change in rotational KE:* The work done by the moment goes into changing the body's rotational kinetic energy. Specifically, $M\,\Delta\theta = \frac{1}{2}I(\omega_2^2 - \omega_1^2)$ if M is the net effective torque on the body. This formula comes from the rotational form of Newton's second law ($M = I\alpha$) combined with kinematics, but the work–energy viewpoint cuts straight to energy.
- *Application:* Use this when you have a **pure rotation scenario** – for example, a flywheel being accelerated by a motor, a turntable slowing down due to a brake torque, or a door being pushed open by a constant force at a distance (creating a moment). Rather than computing angular acceleration and time, you can directly relate the applied moment to the resulting angular speed.
- *Sign convention:* If the torque *adds* rotational speed (doing work *on* the body in direction of motion), take work as positive. If the torque opposes the rotation (like a brake), it's doing negative work (removing energy). As always, the sign of $M\,\Delta\theta$ should align with whether the rotation sped up or slowed down.
- *Consistent units:* Make sure to use radians for $\Delta\theta$ in calculations. A common oversight is using degrees – remember 1 rad ≈ 57.3°, so mixing units will throw off the result. Also ensure torque is in the correct units (N·m in SI, or ft·lbf in US) so that $M\theta$ yields energy (J or ft·lbf).

Equation Passport: Work Done by a Constant Moment (Torque)

Name and purpose: *Work of a Moment – calculates the work done by a constant torque acting on a body through an angular displacement, and relates it to the change in rotational energy.*

Equation:

$$U_M = M\,(\theta_2 - \theta_1),$$

for a constant moment M. Here $\theta_2 - \theta_1 = \Delta\theta$ is the angle (in radians) through which the moment acts. If M is not constant, use $U_M = \int_{\theta_1}^{\theta_2} M\,(\theta)\,d\theta$ instead. In either case, this work translates into $U_M = \Delta!\,(\frac{1}{2}I\omega^2)$ for the rigid body's rotation.

Variables and units:

- U_M: work done by the moment M, in joules (J) if using SI units (also N·m, which is equivalent to J for work) or in foot-pounds (ft·lbf) in US customary units.

- M: constant moment (torque) applied to the body, in N·m (which is J/radian) in SI, or in ft·lbf in US units.

- θ_1, θ_2: initial and final angular positions of the body (radians). The difference $\Delta\theta = \theta_2 - \theta_1$ is the angle through which the body rotates while the moment is applied.

- I: mass moment of inertia of the body about the axis of rotation (kg·m² in SI). This is the same I that appears in rotational kinetic energy $\frac{1}{2}I\omega^2$ and in $M = I\alpha$.

- ω_1, ω_2: initial and final angular speeds (rad/s). They are related to the work by $M\,\Delta\theta = \frac{1}{2}I(\omega_2^2 - \omega_1^2)$ if M is the net torque accelerating the body. (This comes from combining $M = I\alpha$ with $\omega_2^2 = \omega_1^2 + 2\alpha\Delta\theta$.)

Assumptions and scope:

- We assume rotation about a **fixed axis** (or effectively fixed for the duration of motion). The axis could be through the center of mass or not, but I should correspond to that axis. For example, a wheel rotating about its center, or a door rotating about its hinge – both qualify, just use the correct I.

- The moment M is treated as constant in the main equation for simplicity. Many practical cases involve constant torques (e.g. a motor providing a steady torque, or a friction brake with roughly constant resisting moment). If M varies significantly, you would integrate it – but that usually requires a function for $M(\theta)$, which is beyond typical FE exam scope unless a graph is provided to integrate graphically or numerically.

- No other external work influences rotation in the scenario (or they are accounted separately). If other forces do work (like a weight causing rotation via a pulley), you might prefer to solve via the full work–energy principle (as in S02) rather than isolate the $M\theta$ form. This formula is often used when the torque is the primary actor changing the rotational speed.

- The equation inherently assumes **rigid body rotation** (no deformation, so all work goes into changing rotational KE, not internal energy). Also, it assumes the rotational motion is starting from ω_1 and ending at ω_2 without intermediate energy losses (no significant air resistance or such, unless included as another torque).

Limit tests:

- If $M = 0$, then $U_M = 0$. No torque means no work done, which should correspond to no change in rotational kinetic energy (ω_2 stays equal to ω_1). This checks out: a free-spinning object with no moment acting won't change speed.

- If $\Delta\theta = 0$ (no rotation), $U_M = 0$ as well – no angular displacement means even a nonzero torque doesn't do work (like pushing on a locked shaft that doesn't turn: force is applied but no motion, so no energy transfer).

- As a rough check: suppose a 10 N·m torque acts to accelerate a disk over 2 radians. The work done is $U = 20$ J. This should equal the change in $1/2I\omega^2$. If the disk's I is 5 kg·m², then $\Delta\left(\frac{1}{2}I\omega^2\right) = \frac{1}{2}(5)(\omega_2^2 - \omega_1^2) = 20$. Solving, $\omega_2^2 - \omega_1^2 = 8$, so if it started from rest, $\omega_2 = \sqrt{8} \approx 2.83$ rad/s. If you did a more detailed dynamics calc, you'd find $\alpha = M/I = 2$ rad/s^2, then to rotate 2 rad starting from 0, $\omega_2^2 = 2\alpha\Delta\theta = 222 = 8$, same result. The work–energy approach got it in one step.

Use vs. sibling equations: Use $U = M\Delta\theta$ instead of $W = Fd$ when dealing with pure rotations caused by a moment. Think of M (torque) as the rotational analog of force, and θ (in radians) as the analog of linear displacement. This equation is essentially a subset of the general work–energy principle (it's the rotational part). If a problem involves both translation and rotation, you'll likely use the more comprehensive work–energy equation from S02. But if it's just a rotating object with a given torque and you need the angular velocity, $M\Delta\theta = \frac{1}{2}I(\omega_2^2 - \omega_1^2)$ is the go-to formula (no need to separately consider linear motion). Also note, if multiple torques act, you can sum them up (net torque) to use in this equation, or better yet, account for each torque's work and add them – same outcome either way.

Common exam traps:

- **Degree vs Radian:** As mentioned, forgetting to convert angles to radians will yield an incorrect work value. For example, a torque of 5 N·m through 180°: using degrees, one might mistakenly do $5 * 180 = 900$ "J", whereas the correct work is $5 * \pi$ rad ≈ 15.7 J. That's a huge difference! Always use radians in Mθ. On the exam, angles given in revolutions or degrees should ring a bell to convert before applying this formula.

- **Confusing torque work with force work:** If a problem involves a force applied at some radius causing rotation, you have two ways to compute work, and they are consistent: (1) use the force times the arc length traveled by its point of application, or (2) use the equivalent torque times angle. Students sometimes mix these up or double-count. **Use one method per force.** For instance, if a rope unwinds from a drum, you can calculate work done by tension either as T × rope length unwound or as T × R × θ (where T is rope tension, R drum radius, θ radians turned, and TR is the torque). These give the same result. Don't plug T into both Fd and Mθ separately – pick the appropriate form for each actor.

- **Ignoring rotational inertia in energy problems:** In pure rotation cases, you must use the rotational inertia I. A classic mistake is to treat a rotating object as if m (mass) directly gives rotational kinetic energy like $\frac{1}{2}mv^2$. That doesn't work; use $\frac{1}{2}I\omega^2$. I captures how mass is distributed relative to the axis. Two objects with the same mass but different I (one with mass far from axis vs one concentrated near axis) will have different angular accelerations for the same torque and thus different ω for a given work input. Always ensure you have the correct I value from geometry or a given table when solving $M\theta$ problems.

- **Sign of work in slowing scenarios:** If the problem describes something like a brake applying a torque to slow a wheel, students sometimes plug into $M\Delta\theta$ without a sign and get a positive number, then equate it to $\Delta\left(\frac{1}{2}I\omega^2\right)$ and end up increasing energy (which is unphysical). Remember, if $\omega_2 < \omega_1$, $\Delta\left(\frac{1}{2}I\omega^2\right)$ is negative. If you put $M\Delta\theta$ on the left, it should be negative too for a braking torque (because the torque opposes rotation direction). The safest approach is to assign a positive direction: say the wheel's rotation direction is positive; if the brake torque is opposite, treat M as negative in the formula. Then $M\Delta\theta$ comes out negative, matching the loss of KE. In short: a resisting moment does negative work – don't forget that in sign conventions.

Exam Handbook Search Cues (Not affiliated with or endorsed by NCEES): *torque work, work of couple, $M\theta$ formula, rotational kinetic energy change*

Special Notes: Modern FE exam problems often combine rotation and translation – for example, a wheel rolling without slipping where both Fd work and $M\theta$ work are involved, or a pendulum where gravity does work while it swings. Always identify whether each force is causing translation or rotation or both, and apply the appropriate work formula. For pure rotation about a fixed axis, $M\theta$ is usually all you need. For general motion, include both **F** · **s** and

$M\theta$ terms as applicable in the work–energy equation. Finally, remember to use the allowed calculator effectively: you can directly compute values like $\frac{1}{2}I\omega^2$ and $M\theta$ – just be careful with parentheses and unit conversions. Practicing a few energy method problems will build the speed and confidence to tackle these on exam day, ensuring you recognize when to use work–energy to bypass more cumbersome methods.

Topic 10 - Impulse–Momentum

Topic Introduction: Impulse–momentum principles connect force *over time* to changes in motion. This topic matters on the **FE Mechanical Exam** whenever you encounter collisions or short-duration forces. Instead of working through acceleration step by step, you can use impulse–momentum to **jump directly** from forces (or impulses) to velocity changes. Typical exam questions include objects hit or dropped (impulsive forces), sudden starts/stops, or collisions where **energy isn't conserved** but momentum is. Mastering this topic means you'll quickly recognize when to conserve momentum (no external impulse) or apply an impulse calculation to find an aftermath velocity. It's a favorite for exam scenarios like vehicle bumpers, ballistic pendulums, or any "before-and-after" impact problem – where using Newton's F=ma directly would be cumbersome. Below, we break down the impulse–momentum tools for linear motion, rotation, and collision applications, each with a "passport" of what the formula does, how to use it, and how not to mess it up on exam day.

K07.T10.S01 – Linear Impulse–Momentum (Rigid Body Center of Mass)

Principle Introduction: *The linear impulse–momentum principle for a rigid body's center of mass treats the entire body like a single particle:*

- **Force integrated over time equals change in momentum:** Instead of F = ma at every instant, we integrate force *F(t)* over a time interval to get an impulse. This impulse directly gives the change in linear momentum *(mass × velocity)* of the body's center of mass.
- **Derived from Newton's 2nd law:** If mass *m* is constant, $m\frac{dv}{dt} = F$. Integrating from t_1 to t_2 yields $m(v_2 - v_1) = \int_{t_1}^{t_2} F\ dt$. In words: **Net Impulse = Change in Momentum**.
- **Treat the rigid body as a particle at its center of mass:** All external forces on the body contribute to changing the center of mass velocity. Internal forces (within the body) cancel out and do not affect overall momentum. This is why we can lump the whole mass into one and use its velocity.
- **Use for short, significant forces:** This principle shines for **impulsive forces** – large forces acting briefly (hammer blows, collisions) – or whenever you know the total impulse (like a force–time graph area) and need the resulting speed. It bypasses solving differential equations or motion stepwise.
- **Direction matters:** Momentum is a **vector**. Apply the equation separately in each direction (e.g. x and y) if needed. Choose a positive direction and stick with it – impulses and velocity changes in the opposite direction will be negative.

Exam Handbook Search Cues (Not affiliated with or endorsed by NCEES): impulse, momentum, linear momentum, impulse-momentum principle, $m\Delta v = \int F dt$

Equation Passport – Linear Impulse–Momentum
Name and purpose: Linear Impulse–Momentum Equation – calculates the change in a rigid body's center-of-mass velocity from a force acting over time. Use this to find **after-impact speed or required stopping force** without solving $a = F/m$ step by step.

Equation (one-dimension, along a chosen axis):

$$m\,v_2 - m\,v_1 \;=\; \int_{t_1}^{t_2} F_{\text{net}}(t)\,dt \;=\; J_{\text{net}}$$

(This is the vector form compressed into one direction. J_{net} is the total impulse from all external forces over the time interval.)

Variables and units:

- m – mass of the rigid body (assumed constant), in **kg** (SI) or **slug** (US customary).
- v_1, v_2 – initial and final center-of-mass velocities along the chosen direction, in **m/s** (SI) or **ft/s** (US).
- $F_{\text{net}}(t)$ – net external force as a function of time, in **N** (newtons) or **lbf** (pound-force).
- $J_{\text{net}} = \int_{t_1}^{t_2} F_{\text{net}}\ dt$ – net impulse applied to the body, in **N·s** or **lbf·s** (equivalent to **kg·m/s** in SI units).

Assumptions and scope:

- **Constant mass:** The formula assumes m stays the same during the interaction. (No rockets or mass loss here – those require a more advanced approach.)

- **Short time interval (impulse approximation):** Often used when forces act over a brief period. During that blink, you can neglect other gradual forces like weight if they're comparatively small. *(Example: During a collision lasting 0.01 s, gravity's impulse is negligible.)*

- **Particle approximation:** The entire rigid body's translational motion is characterized by its center of mass. We don't track rotation here (that's handled separately).

- **External forces only:** Impulses from **external** forces change the momentum. Internal forces (inside the body) come in equal-opposite pairs and cancel out overall.

Limit checks (sanity tests):

- If no net force acts ($F_{\text{net}} = 0$ over the period), then $\int F dt = 0$ and the equation gives $mv_2 = mv_1$ – no change in momentum (which makes sense: without impulse, velocity stays the same).
- If the interaction time $\Delta t = t_2 - t_1$ is extremely short (approaches 0), a finite change in velocity requires an extremely large force. Conversely, for a given desired Δv, a longer push (bigger Δt) means a smaller required force (spreading the impulse out).

Use this equation instead of the basic kinematic formulas or Newton's $F = ma$ *when dealing with a sudden force or collision*. It's especially useful when you know the total impulse (or momentum change) but not the detailed acceleration. Also use this in place of energy methods when energy isn't conserved (e.g. inelastic collisions) but you still need a velocity change – momentum will get you there reliably.

Common exam traps:

- **Ignoring direction:** Forgetting that momentum (and impulse) has direction. Always assign a positive direction first. If you get a negative velocity from the math, it means the motion is opposite to your assumed direction – not a math error.

- **Forgetting all forces:** Not accounting for *all* external impulses. For instance, if a crate slides and stops due to friction, the friction force over time provides an impulse that *removes* momentum. Include it, or you'll wrongly think momentum is magically lost.
- **Mismatched units:** Mixing units for impulse and momentum. *Example:* Using mass in **lbm** with force in **lbf** directly will mislead you – in US units, convert mass to slugs or include the factor g_c. *(1 lbf acting for 1 s imparts 1 lbf·s of impulse, which equals 1 slug·ft/s of momentum change.)*

- **Assuming energy conservation:** Impulse–momentum does **not** account for energy. Don't confuse momentum conservation with energy conservation. An object can have the same momentum before/after an event while mechanical energy is lost (to heat, deformation, etc.). The exam may set traps where using energy would be incorrect but momentum holds (e.g. perfectly inelastic collision – momentum conserved, energy *not* conserved).

Footnotes:

- In the **FE exam reference**, look for keywords like "impulse and momentum" or formulas with $\int F\,dt$ to quickly find this principle. It's often listed in the Dynamics section under linear momentum.

- Momentum units: 1 **N·s** = 1 **kg·m/s**. In US Customary, 1 **lbf·s** = $1\frac{\text{lbm·ft}}{\text{s}}$ (since 1 lbf = 1 lbm · 32.174 ft/s^2, there's an implicit g_c if you mix units). Remember to be consistent.
- The symbol J is often used for impulse (don't confuse with mechanical work W or energy E). Some texts use I for impulse – on the exam, focus on the context (units N·s vs N·m for moments, etc.).

Variations and related forms:

- **Average force approximation:** If the problem gives an average force $\bar{F}$ or assumes a roughly constant force during Δt, you can simplify $\int_{t_1}^{t_2} F\ dt \approx \bar{F}\,\Delta t$. This is handy for quick estimates: $m(v_2 - v_1) \approx \bar{F}\,\Delta t$.

- **Vector component form:** The full vector form is $\vec{p}_2 = \vec{p}_1 + \vec{J}$. In component form: $m\,(v_{2x} - v_{1x}) = \int F_x\,dt$, and similarly for y or z. Solve independently per direction.

- **Multiple impulses:** If several forces act at different times, you can sum all their impulses: $m\Delta v = J_1 + J_2 + \cdots$. Impulses are additive as vectors. Just take care to include the sign of each (based on direction).

- **Impulse in collisions:** When two bodies collide, each experiences an impulse of equal magnitude and opposite direction (Newton's 3rd law). One body's momentum decreases, the other's increases by the same amount. This subtopic covers single-body momentum changes; we'll handle *systems* (two-body collisions) later with conservation principles.

Special notes (calculator tips): No complex computations are typically needed beyond basic arithmetic. Ensure consistency of units before plugging numbers. Use parentheses when computing an impulse from a force–time expression. For example, if given a piecewise force, compute area segments separately. On a TI-36 or Casio, you might compute $J = F \times \Delta t$ directly. Remember that the exam's on-screen handbook provides standard formulas if you recall the keywords to search – but it won't do unit conversions for you, so double-check those manually.

Explanation & Analysis (Step-by-Step): The linear impulse–momentum equation is essentially Newton's second law in "integral form." Here's how you *apply* it on a typical problem:

1. **Define your system and direction:** Decide which object (or set of objects) you're analyzing. Draw a quick sketch if needed. Pick a convenient axis for the motion (e.g. along the direction of the force or velocity). Declare, for example, "to the right is positive." This sign convention is crucial – stick with it consistently for forces, velocities, and impulses.
2. **Identify initial and final states:** Determine the object's velocity v_1 at the start (t_1) and velocity v_2 at the end (t_2) of the impulse. These could be given, or you might assume something is initially at rest ($v_1 = 0$) or comes to rest ($v_2 = 0$). Write them down with proper sign (e.g., if the object rebounds opposite to your + direction, its v will be negative).
3. **Sum up external impulses:** Figure out all external forces acting on the body during the time interval. Common ones: an impact force, thrust, friction, weight, normal forces. Most times, one force dominates (like the blow of a hammer) and others are negligible for that short duration. Compute the impulse of each: impulse = force × time if constant, or the area under F–t curve if variable. Include the direction (an impulse opposite to your axis is negative). Then sum them to get J_{net}. If the problem directly gives you an impulse value (e.g., "the impulse delivered is 300 N·s"), you're a step ahead – use that.
4. **Apply $m(v_2 - v_1) = J_{\text{net}}$:** Plug in the mass (in the correct units) and the net impulse (be mindful of its sign). Solve for the unknown. Often you're solving for v_2 (final velocity) since that's typically what happens after an impulse. Algebraically: $v_2 = v_1 + J_{\text{net}}/m$. This formula makes sense: you start with v_1 and then add a kick of J/m. If J is positive (in direction of +), v_2 ends up larger; if J is negative (opposite direction), v_2 could decrease or even reverse sign.
5. **Check the result for physical sense:** After computing, pause and interpret. Did a positive impulse increase the velocity in the expected direction? If the object was initially stationary and you applied an impulse, it should now be moving (non-zero v_2). If something was moving and an opposite impulse stopped it, does your result show v_2 around zero or negative (reversal)? Also double-check units: kg·m/s on the impulse-momentum side should yield m/s for velocity. If you accidentally used mass in grams or force in pounds without converting, the number will be off.
6. **Remember momentum conservation as a special case:** If $J_{\text{net}} = 0$ (no external impulse), then $mv_2 = mv_1$. That's momentum conservation for one object – it keeps moving at constant velocity if nothing external pushes/pulls it. In collision problems, if you consider two objects together as a system, internal forces don't count, so total momentum stays constant (we'll cover that soon). Recognize those scenarios: no external force →

momentum is *conserved*. This can simplify many problems (no calculation needed beyond setting initial momentum = final momentum).

By mastering the linear impulse–momentum equation, you equip yourself with a go-to tool for any problem where force × time is given or asked. It's quick, it's reliable, and it reflects a fundamental truth: **you can trade force and time for motion**. On the FE exam, whenever you see a short interaction (like "a 50 N force acts for 0.2 s..." or "two skaters push off each other..."), think impulse–momentum. You'll solve it in one or two lines, while others waste time fiddling with unnecessary details.

K07.T10.S02 – Angular Impulse–Momentum (Rigid Body Rotation)

Principle Introduction: *The angular impulse–momentum principle extends the idea of impulse to rotation:*

- **Moment integrated over time equals change in angular momentum:** Just as force over time (impulse) changes linear momentum, a **moment (torque) over time** changes angular momentum. For a rigid body, that means a net torque impulse causes a change in rotational speed.
- **Rigid body rotation about an axis:** If a rigid body can rotate (about its center of mass or a fixed pivot), we consider its moment of inertia I and angular velocity ω. The equation $I(\omega_2 - \omega_1) = \int M_{\text{net}} dt$ gives the change in angular velocity from an angular impulse (integrated torque) applied.
- **Include off-center forces:** A force applied **off the center of mass** produces a moment ($M = F \times$ lever arm) that causes rotation. In angular impulse–momentum, any linear impulse J acting at a distance r contributes an angular impulse $J \cdot r$. In other words, forces not through the centroid make the body spin. The equation naturally accounts for this by using the net moment M due to all forces.
- **Use for sudden rotations or impacts:** This principle is your go-to for problems like a door slammed by a push (find resulting ω), a rod struck by a clay lump, or any scenario where something starts rotating due to a quick hit or torque. It bypasses having to compute angular acceleration over time – you jump from applied impulse directly to angular speed change.
- **Choice of axis is crucial:** We often apply angular momentum about the center of mass or about a fixed pivot. Pick the point/axis about which you'll write the equation, and be consistent: use I about that same axis and include the moments of all impulses about that axis. If the body is free (no fixed axis), the center of mass is a convenient reference.

Exam Handbook Search Cues (Not affiliated with or endorsed by NCEES): angular momentum, angular impulse, $I\omega$, principle of angular impulse-momentum, $\int M\, dt$, rigid body rotation

Equation Passport – Angular Impulse–Momentum
Name and purpose: Angular Impulse–Momentum Equation – relates a torque impulse on a rigid body to its change in angular velocity about a chosen axis. Use this to find **how an object's rotation speed changes** when hit by a moment or off-center force (especially in impulsive events like collisions or sudden turns).

Equation (rotation about a fixed axis or center of mass):

$$I\,\omega_2 \;-\; I\,\omega_1 \;=\; \int_{t_1}^{t_2} M_{\text{net}}(t)\,dt$$

This can be written as $I(\omega_2 - \omega_1) = M_{\text{net}}\,\Delta t$ if M is constant, or summed if multiple impulses act. It's the rotational analog of $m(v_2 - v_1) = \int F dt$. The left side is the change in **angular momentum** $I\omega$, and the right side is the **angular impulse** (the time-integral of net external moment about the axis).

Variables and units:

- I – moment of inertia of the body about the chosen axis, in **kg·m²** (SI) or **slug·ft²** (US). *Make sure this is about the same axis around which you sum moments.*

- ω_1, ω_2 – initial and final angular velocities, in **rad/s**. (If the body was not rotating initially, $\omega_1 = 0$.)

- $M_{\text{net}}(t)$ – net external moment (torque) about the axis, as a function of time, in **N·m** (SI) or **lbf·ft** (US). This net moment includes contributions from all forces: for each force F, use its perpendicular distance to the axis $r_\perp$ and direction to get the moment ($M = F \times r_\perp$, sign based on rotation direction).

- $\int_{t_1}^{t_2} M_{\text{net}}\, dt$ – **angular impulse**, with units **N·m·s** in SI (which is equivalent to **kg·m²/s**, same as angular momentum units). In US units, use **lbf·ft·s** (equivalent to slug·ft²/s).

Assumptions and scope:

- **Rigid body, fixed axis (or about mass center):** The body's mass distribution stays constant (no pieces flying off). Either the rotation axis is through the center of mass or it's a fixed pivot (like a hinge). If it's a fixed pivot, I should be about that pivot (use parallel-axis theorem if needed).

- **No external angular momentum from outside the axis:** The equation considers moments about the axis chosen. If the body receives an impulse not through that axis, include its moment about the axis. If the axis is moving, you might need to be careful (typically, choose center of mass or a stationary axis to avoid extra terms). For the FE exam, most problems stick to a stable axis (center of mass or fixed support).

- **Short interaction or known torque-time behavior:** Often used for impulsive torques (like a sudden twist) or impact problems. If a constant torque M is applied for time Δt, it's straightforward: $I(\omega_2 - \omega_1) = M\Delta t$. If $M(t)$ varies, you'd integrate (but exam problems usually simplify this or give the resultant impulse directly).

- **Planar (2D) rotation:** We assume rotation in a plane (1 degree of freedom in angle). If a body has complex 3D rotation, the exam will avoid heavy vector math – they'll likely constrain it to planar or about a principal axis so you can use this scalar form.

Limit checks:

- If no net moment acts ($M_{\text{net}} = 0$ for the duration), then $\int M dt = 0$ and we get $I\omega_2 = I\omega_1$. Canceling I (assuming it's non-zero), $\omega_2 = \omega_1$. No surprise – without any twist applied, the rotational speed doesn't change (angular momentum stays constant by itself).

- If the moment acts impulsively for a very short time, the equation shows even a huge change in ω requires only a finite impulse (area under big spike). Conversely, a small constant torque acting over a long time (large Δt) can achieve the same $\Delta\omega$ as a big spike over a

short time – it's the total impulse that matters, not how you deliver it.

- Check extreme mass distributions: If I is very large (object with most of its mass far from axis), the same angular impulse yields a smaller $\Delta\omega$ (harder to spin). If I is tiny, the same impulse gives a huge spin-up (easy to spin). This aligns with physical intuition: it's harder to twist a heavy flywheel than a light disk with the same effort.

Use this equation instead of trying to use $\tau = I\alpha$ with kinematics when dealing with a *brief* interaction or collision. Also use it instead of energy methods when the problem involves an impact or friction where mechanical energy is lost but you still need rotational speeds. For example, **use angular impulse–momentum rather than work-energy** for a door hit by a moving object – because energy might go into sound or deformation, but angular momentum (about the hinge) will be conserved during the instant of impact (if the hinge exerts no moment). If the problem gives you an impulse or a sudden torque, this formula gets you ω directly, whereas integrating α or using $M = I\alpha$ stepwise would waste time or require information you don't have.

Common exam traps:

- **Wrong axis for I or M:** The most common mistake is inconsistency in the axis. If you sum moments about the center of mass, use I_{center} and exclude any moment due to the object's weight through that center (weight through center has no moment about center). If you choose a pivot point (say a hinge), use I_{pivot} and include moments of all forces about that pivot *except* the pivot reaction (which has zero moment at the pivot). Mixing up axes will give incorrect ω. Always clearly define: "I'm taking moments about point O," then stick to that.

- **Missing the impulse from a linear force:** When a force hits an object off-center, students sometimes plug it into the linear momentum equation but **forget to include its rotational effect**. Remember: any force can both translate the center of mass *and* rotate the body if not through the centroid. In calculations, you should use **both** linear impulse–momentum (for the center of mass velocity) and angular impulse–momentum (for rotation about center) as needed. Don't double-count or omit: the force F for time Δt gives impulse $J = F\Delta t$ (goes into $m\Delta v$) and also a moment impulse Jr (goes into $I\Delta\omega$), where r is the perpendicular offset.

- **Sign conventions (CW vs CCW):** Just like linear direction, you must choose a positive rotation direction (commonly counter-clockwise as positive, but you can choose either as long as you stay consistent). If the applied moment or resulting angular velocity is opposite to your chosen positive, it should carry a negative sign. A typical slip is to drop the sign for an impulse that actually opposes the initial rotation, leading to subtracting when you should add (or vice versa). Always assign + for, say, counter-clockwise. If a clockwise hit occurs, its moment impulse goes in as negative in your equation.

- **Units confusion for moments:** In SI, using N·m for torque is straightforward (N·m·s for angular impulse). In US units, ensure you work in consistent units: use lbf·ft for torque and slug·ft² for inertia. If you plug a mass in lbm and distance in ft directly into inertia, you need to divide by g_c (32.174) to get slug·ft². It's safer to convert mass to slugs first when doing angular momentum in US units.

- **Neglecting the pivot's impulse (if any):** For a body on a pivot, the pivot force can provide an impulse that changes linear momentum (preventing the center of mass from translating through the support). However, the pivot force has **no moment about the pivot itself**, so angular momentum about the pivot is conserved if no other external moments act. Students might be confused why momentum isn't conserved linearly but *is* conserved angularly about the pivot – it's because the pivot's impulse is an external force (changing linear momentum), yet it produces zero torque about the pivot (so it doesn't change angular momentum about that pivot). The exam may exploit this with a problem where you should write angular impulse–momentum about the hinge to avoid dealing with the unknown hinge impulse.

Footnotes:

- Moment of inertia I depends on the axis. The exam handbook provides common I formulas (e.g. $I = \frac{1}{12}mL^2$ for a rod about its center, etc.). Use the correct one for the axis in question – you may need the parallel-axis theorem ($I_{\text{pivot}} = I_{\text{center}} + md^2$) if the rotation is about a point other than the center of mass (distance d away).

- Angular momentum H is often noted as $I\omega$ for rotation about the mass center. If you take moments about another point O, the total angular momentum about O includes both rotation about the center and the extra term from the center-of-mass motion: $H_O = I_G\omega + mv_G r_\perp$ (this is more advanced, but essentially the translational momentum contributes to angular momentum about O). For a fixed pivot, v_G is due to rotation anyway, so $I_O\omega$ already accounts for it.

- The exam might phrase "angular impulse" in a wordy way, e.g. "a torque of 20 N·m applied over 0.5 s". Multiply to get 10 N·m·s of angular impulse. Recognize that N·m·s is the same unit as kg·m²/s (since 1 N = 1 kg·m/s²).

- You might see symbols: H or L for angular momentum, τ for torque (instead of M). In the exam context, M is often used for moments/torques to avoid confusion with stress or internal torque T. Just be flexible with notation: focus on units and context.

Variations and related forms:

- **Impulse from a constant torque:** If a constant moment M acts for time Δt, a quick-use form is $\Delta\omega = \frac{M\,\Delta t}{I}$. This is just the integrated form for a constant torque, useful if you're given a torque value directly (e.g., a motor applies a 5 N·m torque for 2 s to a flywheel).

- **Multiple contributions:** If more than one torque or off-center force acts, you can sum their impulses: $I(\omega_2 - \omega_1) = \sum(M_i\Delta t_i)$ if they act separately in sequence, or $I\Delta\omega = \int(\sum M)dt$ if simultaneously. Just ensure all M_i are about the same axis and take care with sign (clockwise vs counter-clockwise).

- **Using center of mass vs. other point:** A powerful trick: if a rigid body is subject to an impulsive force not through its center, you can often simplify by writing angular impulse–momentum about an appropriate point. For example, a rod on a frictionless table hit at one end – write the equation about the center of mass or about the hit point to avoid unknown forces. If the body is pinned, writing about the pin (hinge) simplifies because the hinge's impulsive reaction has no moment about itself, so you don't need to consider it in the moment sum.

- **Connection to linear impulse–momentum:** These equations can be used in tandem. Example: A ball hits a rod and they start moving together – use linear impulse–momentum for the center-of-mass velocity and angular impulse–momentum for the spin. Both must

be satisfied. In such "combined translation and rotation" outcomes, you might need the relationship $v_G = \omega \times$ (distance) if the object rolls without slipping or something similar (likely beyond FE scope unless clearly stated).

- **Typical values:** Angular impulses can be small if the moment arm is small or time is short. A quick mental check: a 1 N·m torque over 1 s on a 1 kg·m² object changes ω by 1 rad/s (since 1 N·m·s = 1 kg·m²/s). If you see an extremely high ω result, check if the moment or time was large or if a unit conversion was missed.

Special notes (calculator): As with linear, these problems usually come down to basic arithmetic or maybe a two-step calculation (finding I, then ω). *Casio fx-115/991 Tip:* Use the memory or multi-line feature to store I if you compute it, then do $\omega_2 = \omega_1 + \frac{M\,\Delta t}{I}$ directly. *TI-36 Tip:* Be careful inputting scientific notation for I if it's a small or large number (the TI-36X Pro can handle it, just double-check you entered the powers of ten correctly). If using degrees for angles in other parts of a problem, note that angular velocity in these formulas must be in rad/s (the calculator won't know the difference, it's on you to use radians in the formula). Generally, units consistency is the main thing – the math itself is straightforward.

Explanation & Analysis (Step-by-Step): Angular impulse–momentum is applied similarly to its linear counterpart, but now we're dealing with rotation:

1. **Draw a diagram and choose an axis:** Start by sketching the rigid body and marking the axis about which you will apply angular momentum. Good choices are typically the center of mass (if the body is free) or a fixed hinge/pivot (if attached). Mark any forces and their lines of action, along with distances to the chosen axis. Indicate a positive rotation direction (e.g., "counter-clockwise positive"). This helps you visualize which way each force tends to spin the body.
2. **Identify initial and final angular speeds:** Determine ω_1 (initial angular velocity) and ω_2 (final angular velocity). Many problems have the object initially not rotating ($\omega_1 = 0$). If it was already spinning, note the direction (e.g., clockwise 20 rad/s might be -20 rad/s if you set CCW as positive). The final angular velocity ω_2 might be what you're solving for, or given (like it comes to rest, so $\omega_2 = 0$).
3. **Compute the moment of inertia I:** Using the geometry and mass of the object, find I about your chosen axis. The exam may give a value or a simple shape formula (like for a disc, rod, etc.). Pay attention to units (convert mass to kg for SI, slugs for US if needed, and use the correct length units). Write down I so you don't forget it in the equation.
4. **Calculate angular impulse (integrated moment):** For each external force or torque, find the impulse it imparts about the axis over the time interval.
5. If you have a pure torque (like a motor applying M constantly), just do $M \times \Delta t$.
6. If it's a force F at a perpendicular distance $r_\perp$, the moment is $M = Fr_\perp$. If that force is applied over time Δt, its angular impulse is $M\Delta t = Fr_\perp \Delta t = J\,r_\perp$ (where $J = F\Delta t$ is the linear impulse).
7. If the force direction or magnitude changes in time, integrate or find the area under the $M(t)$ curve (the exam usually spares you heavy integration – they might provide an equivalent impulse or a simple shape to integrate graphically).
8. Sum up all the angular impulses: $\int M_{\text{net}} dt =$ (Impulse from force1) + (Impulse from force2) + ⋯. Remember to treat clockwise vs counter-clockwise as positive vs negative when summing. For instance, if one torque tries to spin the body clockwise and another counter-clockwise, they subtract.
9. **Apply $I(\omega_2 - \omega_1) = \int M dt$:** Plug in I, ω_1, and the total angular impulse. Solve for the unknown, often ω_2. Algebra tip: it will look like $I\omega_2 = I\omega_1 +$ (angular impulse). So $\omega_2 = \omega_1 + \frac{1}{I}\int M dt$. This step is conceptually the "big picture": initial angular momentum plus added angular impulse equals final angular momentum. If the object was initially stationary, the left side starts at 0, and you're just equating $I\omega_2$ to the applied impulse.
10. **Analyze the result:** Does the sign of ω_2 match the expected rotation direction? If you got a negative ω_2 but expected a clockwise spin and you defined clockwise as negative, then it's actually correct physically (the object spins clockwise). Check extreme cases: if the applied impulse was zero, did your equation correctly keep $\omega_2 = \omega_1$? If a very large impulse was applied, did ω_2 come out very large? – it should, proportionally. Also double-check no outside influences were overlooked: was there any external support providing a moment you neglected? If we chose the center of mass for analysis and there was no external anchor, we included all forces' moments. If we chose a hinge and neglected hinge force (good, since it has no moment at hinge), we implicitly assumed hinge had no friction (no resisting moment). These are typically stated in the problem (e.g., "smooth hinge" or "no friction") – just be aware of them.
11. **Combine with linear momentum when needed:** If the problem also involves translation (like a free body getting both a velocity and rotation), you'd simultaneously use the linear impulse–momentum for the center of mass motion (from Subtopic 1) *and* angular impulse–momentum about the center. The two equations can give two unknowns (e.g., final v_{CM} and ω after a hit). This combined use is common in collision problems – for example, a bullet hits a rod and sticks: linear momentum gives the velocity of the combined center of mass, angular momentum about the center gives the rotation. We mention this here because it's a classic FE scenario. Practice identifying when you need one equation vs two. If rotation is involved and nothing is fixed, expect to use both linear and angular momentum principles together.
12. **Reinforce conceptual understanding:** Angular impulse–momentum is basically saying *rotational motion obeys conservation of angular momentum if no external torque impulse intervenes*. When there *is* an external torque impulse, the change in angular momentum equals that impulse (Newton's second law for rotation integrated). This parallels linear momentum. So you can always cross-check your approach: does it reduce to conservation (no external M) or to something intuitive in limiting cases? If yes, you're on solid ground.

On exam day, spotting when to use the angular impulse–momentum equation can save a lot of time. Look for *keywords*: "suddenly starts rotating," "is struck causing it to spin," "no external moments during impact," or any mention of torque × time. These signal that it's time to roll out $I\Delta\omega = \int M dt$. With a bit of

practice, you'll handle these rotational impulse problems with the same confidence as straightforward linear ones.

K07.T10.S03 – Conservation of Momentum in Collisions (Impulsive Forces & No External Moments)

Principle Introduction: *When no external forces or moments act on a system, momentum is conserved. In collisions or impulsive events, this principle becomes a powerful shortcut:*

- **Isolated system → constant total momentum:** When two or more bodies collide and external effects can be neglected during the brief impact interval, the system's total momentum is the same immediately before and immediately after the collision. This applies to *linear momentum* when there is *no net external impulse*, and to *angular momentum about a point* when there is *no net external impulsive moment about that point.*
- **Collisions often neglect external forces during impact:** Collisions happen fast. Forces like weight or small frictions don't have time to significantly change momentum during the impact, so we treat the bodies as an isolated system. For the short duration of the crash, momentum is exchanged internally between the objects, but the sum stays constant.
- **Linear vs angular momentum conservation:** In a straight-line (central) collision, we conserve linear momentum along the line of impact. If objects also start rotating or if the impact is off-center, we consider angular momentum about a suitable point (often the center of mass of the system or a point about which no external moment acts). The absence of external moment means **angular momentum is conserved** about that point.
- **Coefficient of restitution (energy loss measure):** Momentum conservation doesn't tell us how kinetic energy changes. The *coefficient of restitution* e is introduced to relate the relative velocities before and after collision. It ranges from 1 (perfectly elastic, no kinetic energy lost) to 0 (perfectly inelastic, objects stick together, maximum kinetic energy lost but momentum still conserved). While not part of "momentum conservation" per se, e is often provided in collision problems to determine the final velocities uniquely, alongside momentum conservation.
- **Typical use cases:** Two cars bumping (you assume momentum conserved during the collision itself), a bullet embedding into a block (classic inelastic collision – momentum conserved, energy not), or a satellite docking, etc. For angular momentum: a figure skater pulling arms in (no external torque, so angular momentum conserved, she spins faster), or a rod hit by a clay blob where no external support is present (so total angular momentum about the center of mass is conserved through the impact).

Exam Handbook Search Cues (Not affiliated with or endorsed by NCEES): conservation of momentum, collision, impact, coefficient of restitution, angular momentum conservation, impact of rigid bodies

Equation Passport – Momentum Conservation (Collisions)
Name and purpose: Conservation of Momentum – In the absence of external impulse, the total momentum of a system is the same immediately before an interaction as it is immediately after. Use this to solve collision outcomes **without** needing force details. It's the prime tool for any impact problem on the FE exam where you can treat the participants as an isolated system during the brief collision.

Equation (general statement):
- Linear Momentum (one-dimensional system):

$$m_1 v_{1,\text{before}} + m_2 v_{2,\text{before}} = m_1 v_{1,\text{after}} + m_2 v_{2,\text{after}}$$

(For two bodies along a line. Sum of momenta before = sum after. If more bodies, sum them all. Use components for 2D collisions – conserve momentum in each independent direction.)
- Angular Momentum (about a point O):

$$H_{O,\text{before}} = H_{O,\text{after}}$$

Here H_O is the total angular momentum of the system about point O before and after the event. For example, if a moving object hits a stationary rod and they stick, you might conserve angular momentum about the rod's center (or another convenient point) to find the post-impact rotation.

(Note: $H = I\omega + mvr_\perp$ for any moving parts, summed over all bodies about the chosen point O. You pick O such that no external impulse has moment about O – often the center of mass of the whole system or a symmetry point. In a vertical impact with no external horizontal forces, linear momentum in that horizontal direction is conserved. In a rotation scenario with no external torques, angular momentum about the appropriate axis is conserved.)

Variables and units:

- $m_1, m_2, \ldots$ – masses of the objects involved, in **kg** (SI) or **slug** (US).
- $v_{i,\text{before}}, v_{i,\text{after}}$ – velocities of object i just before impact and just after impact, in **m/s** or **ft/s**. These should be taken along the line of collision or the direction of motion considered. (Use components if needed, e.g., $v_{x,\text{before}}$ etc.)
- H_O – total angular momentum about point O, in **kg·m²/s** or **slug·ft²/s**. If computing H_O, include contributions from each object: for a purely translating object, $H_O = m(v_\perp)(r_\perp)$ (mass × perpendicular component of velocity × distance from O); for a rotating object, add $I_O\omega$.
- e – coefficient of restitution (dimensionless). Not part of momentum conservation formula itself, but used alongside it. e is defined as $e = \frac{\text{relative speed after}}{\text{relative speed before}}$ along the line of impact. Range: $0 \leq e \leq 1$. - If $e = 1$: elastic collision (no kinetic energy lost). - If $e = 0$: perfectly inelastic (objects stick and move together after impact). - Intermediate $0 < e < 1$: partially inelastic (some energy lost, e.g. two cars dent and separate with lower speeds).

Assumptions and scope:

- **Negligible external impulse during collision:** This is key. We assume during the short impact, outside forces (weight, friction, supports) either sum to zero or act for such a brief time that their impulse is negligible compared to the impulses between the colliding bodies. This effectively isolates the system's momentum. (For linear momentum, that means no net external force impulse; for angular momentum about point O, that means no net external moment impulse about O.)

- **Instantaneous interaction:** Collisions are modeled as instantaneous events separating "before" and "after" clearly.

There's no significant movement of the bodies relative to external references during the impact (so we don't, for example, let gravity significantly change things mid-collision).

- **Rigid bodies (no external energy storage):** The objects deform or not, but we don't track that detail – any deformation just manifests as energy loss (via e). Momentum can be conserved even if kinetic energy isn't, as long as no external force takes momentum away. We assume no explosion that adds momentum from nowhere; momentum conservation only holds if the system is closed (no mass entering or leaving either).

- **Collisions can be central or eccentric:** The formula is general. For a straightforward head-on (central) collision, using linear momentum along the line of impact is enough. For an off-center collision (like hitting a door at the knob), use angular momentum about a point (like the hinge or center of mass) to capture rotational effects. The principle still applies as long as that point sees no external torque.

Limit checks:

- If the objects stick together (perfectly inelastic, $e = 0$), momentum conservation simplifies to: $m_1 v_{1,\text{before}} + m_2 v_{2,\text{before}} = (m_1 + m_2) v_{\text{after}}$ (they move with common velocity after). This is a quick way to find that shared velocity. The extreme opposite, $e = 1$, means they bounce off with no energy loss – you'd use momentum and $e = 1$ to solve, and you might notice kinetic energy before = kinetic energy after as a check.

- No external forces → center of mass of the system keeps moving at constant velocity (Newton's 1st law for system). If you compute the combined momentum and divide by total mass, you get the velocity of the center of mass. That velocity will be the same before and after collision in an isolated system. It's a nice sanity check: after solving, compute $v_{CM,\text{after}}$ and $v_{CM,\text{before}}$, they should match. If not, something's off (likely misapplied external impulse or sign error).

- Angular version: If no external torque, the system's total angular momentum about any fixed point remains constant. For example, consider a spinning skater pulling arms in: no external torque, so $I\omega$ stays constant; if I drops, ω increases. In collision terms, if a moving mass hits a stationary rod and sticks, try choosing point = combined center of mass of system – no external torque about that point, so H constant. This is advanced, but it means the combined rotation+translation after will be such that angular momentum about that COM is same as initial angular momentum of the bullet about that COM. It's easier often to pick a point that's stationary or with clear symmetry, like a hinge (no external moment about hinge if frictionless) or the point of impact at the instant of impact (since the impulse force passes through that point, it imparts no moment about itself).

Use this principle instead of trying to compute the details of forces during a collision. The exam will never ask you to find the time-varying force of impact – it's too fast and complex. Instead, **use momentum conservation whenever applicable**: it's much simpler. Also use momentum conservation instead of energy conservation when kinetic energy is lost (e.g. objects stick or deform). Many students instinctively reach for energy equations; if the collision is inelastic, that's wrong. Momentum is the safe bet in collisions. In summary, use momentum conservation rather than Newton's second law or work-energy for instantaneous collisions – it's the only practical tool given limited information about the forces.

Common exam traps:

- **Forgetting vector nature (direction):** In 1D, it's usually left vs right (choose one as positive). Many mistakes come from plugging all speeds as positive numbers regardless of direction. If two cars head toward each other, one velocity must be taken negative in the equation. In 2D collisions, you must conserve momentum in each direction separately – don't mix components. If a problem gives angles, resolve velocities into x and y, conserve each, then recombine if needed.

- **Neglecting an external impulse that *is* significant:** Some situations have external forces that you **cannot** ignore. Example: A ball dropping and bouncing off the floor – the floor actually provides an impulse (external to the ball) that changes the ball's momentum. You cannot conserve the ball's momentum by itself (it clearly changes, the floor took some). If the system is just the ball, momentum isn't conserved because an external impulse from Earth acted. If you included Earth in the system, momentum would be conserved, but that's too large a system to be practical. So be careful: only isolate the system where isolation is reasonable. The exam usually makes it clear: collisions of two objects in free space or on a frictionless surface (isolated), versus something hitting a fixed barrier (not isolated for that single object). In the latter, use impulse-momentum with the external impulse (like from the floor) instead, or conserve momentum for a larger system if appropriate.

- **Mixing up e usage:** The coefficient of restitution formula can trip students. The standard definition along the line of impact is:

$$e = \frac{\text{relative speed after}}{\text{relative speed before}} = \frac{|v_{2,\text{after}} - v_{1,\text{after}}|}{|v_{1,\text{before}} - v_{2,\text{before}}|}.$$

A common trap: using the wrong order or sign. The relative speed before is usually taken as approaching speed (a positive number). After, it's separation speed. You must subtract final velocities in the correct order (typically, $v_{\text{separating}}/v_{\text{approaching}}$). Also, don't apply e in a direction perpendicular to the collision – it only applies along the line of impact (e.g., if two balls collide off-center, e relates their approach/separation speeds along the line connecting their centers at impact; perpendicular components of velocity are unchanged by an ideal instantaneous impact without friction).

- **Assuming energy conservation when not true:** As stressed, if $e \neq 1$, kinetic energy is lost. A classic exam trick is to give you masses and velocities and ask for something like a resulting speed; using energy conservation would be easier math but it's wrong if the collision isn't elastic. Stick to momentum + e for those. Conversely, if they *say* "elastic collision" or $e = 1$, then you can use both momentum and energy to solve (two equations for two unknowns). Just reading carefully to catch whether it's elastic or inelastic is vital.

- **Units and mass ratios:** Ensure consistency in units when calculating momentum. If one mass is given in grams and another in kg, convert them into one unit system before applying the equations. Also, be mindful of big disparities: if $m_1 \gg m_2$, after collision the heavy object's velocity won't change much (nearly constant momentum hog); the light one takes most of the velocity change. This intuition can help check if your solved velocities make sense (e.g., tiny mass bouncing off a huge mass should rebound with nearly the same speed it came in with, just opposite direction if elastic, whereas the huge mass barely budges).

Footnotes:

- The **exam handbook** might list a formula under "Impact" or "Collision" with the coefficient of restitution and momentum equations. The keywords "impact" or "coefficient of restitution" will get you to those reference formulas quickly if you need a reminder. But the concept is straightforward: momentum in = momentum out, adjusted by e for how velocities separate.

- Sometimes problems involve successive collisions or explosions. If something explodes into fragments, momentum of the fragments will also conserve to the pre-explosion momentum (if no external forces). Each piece's momentum vector sums to the original. For collisions in series, apply conservation to each impact separately, with updated velocities carrying forward.

- Rotational collision note: If a collision causes rotation (like hitting an off-center target), decide whether to use linear or angular momentum conservation. You can often do either correctly if you include all pieces. For instance, a bullet hitting a hinged door: no external moment about hinge, so conserve angular momentum about hinge. If you tried linear, momentum of bullet-door system isn't conserved linearly because the hinge imparted impulse. So, the principle is: choose a point where external forces have no moment (for angular) or a direction with no external force (for linear) to apply conservation. This is advanced reasoning typically hinted at in the problem setup.

Variations and related concepts:

- **Explosions or separation:** Momentum conservation isn't just for collisions; it also applies when objects push off each other (spacecraft separating, people on ice pushing apart). The math is the same direction-wise: if two objects start together and push off, with no external forces, their momenta are equal and opposite afterward. On the exam, a classic is two skaters pushing off: they start at rest (zero total momentum), then move in opposite directions such that $m_1 v_1 + m_2 v_2 = 0$.

- **Center of mass motion:** Because momentum is conserved, the velocity of the center of mass of an isolated system stays constant through a collision. This can sometimes provide a shortcut or check. If you find the combined motion after collision, you can double-check by computing the center of mass velocity before and after – they should match. If the problem asks for something like "recoil velocity" of a gun when a bullet is fired, it's essentially using momentum conservation (gun + bullet system, no external force horizontally).

- **Angular momentum in mechanisms:** Occasionally, conservation of angular momentum appears in rotating machinery problems. Example: a flywheel clutch engages another, and they rotate together after – no external torque during engagement, so $I_1\omega_1 + I_2\omega_2 = (I_1 + I_2)\omega_{\text{final}}$. This is analogous to a perfectly inelastic collision but in rotation. It might not be directly tested in FE, but conceptually it's the same principle.

- **Typical restitution values:** $e = 1$ (ideal elastic, like superballs or billiard balls approximately), $e \approx 0.8$ for many ordinary collisions (some bounce), $e = 0$ for perfectly plastic (objects stick). The exam might give a specific e or say "assume elastic" or "plastic." They might also implicitly assume perfectly inelastic if they say the objects stick together after collision. Recognize those keywords: "stick" means $e = 0$. "Bounce without loss" implies $e = 1$. If they don't mention e or sticking, you might assume perfectly elastic for an idealized case unless energy loss is obvious.

Special notes (calculator strategy): Solving collision problems often means solving two equations: momentum and restitution. You might have to do a bit of algebra to get the final velocities. With the FE-approved calculators, it's manageable: - Solve the momentum equation for one variable (say $v_{2,\text{after}}$ in terms of $v_{1,\text{after}}$) then plug into the restitution equation. Do algebra carefully on paper to avoid mis-entering a long expression. - Alternatively, you can plug numbers directly: the calculators can handle solving two linear equations if you set it up, but usually it's faster to do it manually since one equation might be linear momentum (linear in velocities) and the restitution is also linear in velocities for two bodies. - If you use the memory registers, store known values (masses, initial velocities, e) and then compute final ones stepwise. - Always double-check the signs you plug in for velocities based on your chosen positive direction; a sign error is easy to make and hard for the calculator to warn you about. - If no e is given and objects do not stick, consider if you have enough info: sometimes they'll give one final velocity, and you use momentum to find the other. Or if it's totally inelastic (stick together), momentum alone suffices (one equation, one unknown). Your calculator won't tell you if you're applying a wrong principle, so trust the physics first.

Explanation & Analysis (Step-by-Step): Momentum conservation in collisions is often the most direct path to the solution. Here's a general approach for a collision problem:

1. **Define the system and isolate it:** Decide which objects are involved in the collision and mentally draw a boundary around them, excluding any anchors or external bodies that provide force. Example: Two vehicles colliding on ice – system is both vehicles (no friction from ground during impact assumed). A ball hitting a pendulum – system might be ball + pendulum for the instant of collision (exclude the ceiling support if the collision is fast and the string tension during the instant doesn't greatly affect horizontal momentum; or better, use angular momentum about the pivot so the string force doesn't come into play). State to yourself: "No external impulse in [the direction or about the point] I'm considering, so momentum is conserved." This sets the stage.
2. **Set up the momentum balance "before = after":** Write down the total momentum before collision and total momentum after, in the direction of interest or about the chosen point.
3. For linear: pick an axis (say the line of motion). If something is moving left, give it a negative momentum. Sum $m_1 v_1 + m_2 v_2 + \cdots$ before, set equal to $m_1 v_1' + m_2 v_2' + \cdots$ after (using primes or subscripts "after" for clarity).

   For angular: decide the reference point (often the collision point or a pivot). Compute H_O for each body about that point. For a point mass moving linearly, $H_O = mvr_\perp$ (with $r_\perp$ being the perpendicular distance from the line of travel to point O). For a rotating body, include its $I\omega$. Do this sum before and after. This step might seem complex, but in many FE problems it simplifies – either only one body moves initially, or they stick and rotate together after, etc.

   Write the equation equating the two totals. This equation is the mathematical statement of momentum conservation.
4. **Incorporate restitution if needed:** If the problem gives a coefficient of restitution e (and it's not a perfectly inelastic stick-together case), write the restitution

equation: $(v_{\text{separation}})/(v_{\text{approach}}) = e$. Make sure to assign the velocities correctly: usually, if object 1 hits object 2,

$$e = \frac{v_{2,\text{after}} - v_{1,\text{after}}}{v_{1,\text{before}} - v_{2,\text{before}}}$$

assuming $v_{1,\text{before}}$ was toward object 2. The numerator is how fast object 2 moves away from object 1 after, and the denominator is how fast object 1 was closing in on object 2 before (both positive quantities if we take the line of impact direction as positive from 1 toward 2). If you accidentally swap them, you might get an inverse or sign error. When in doubt, derive it logically: if $e = 1$, then $v_{2,\text{after}} - v_{1,\text{after}} = v_{1,\text{before}} - v_{2,\text{before}}$ (they rebound at the same relative speed they approached). If $e = 0$, then $v_{2,\text{after}} = v_{1,\text{after}}$ (they stick, so no separation speed). These checks help set up the formula correctly.

5. **Solve the equations:** Now you have one or two equations. Solve for the unknown final velocity(ies).

   If objects stick ($e = 0$), you effectively had one momentum equation with one unknown (their common velocity after). Solve it easily:

$$v_{\text{after}} = \frac{m_1 v_{1,\text{before}} + m_2 v_{2,\text{before}}}{m_1 + m_2}$$

   If e is given and not zero, you'll have two unknown final velocities and two equations (momentum and restitution). Solve systematically: perhaps solve momentum for one velocity and substitute into restitution. The algebra is usually straightforward (the FE won't give you something requiring quadratic solutions here; linear system solves cleanly).

   If one of the objects is much more massive and essentially doesn't change velocity (like a ball hitting Earth), sometimes they approximate it as Earth doesn't move ($v_{\text{Earth after}} \approx 0$ still). But generally, FE problems stick to manageable ratios or explicitly fixed objects (like a ball hitting a stationary wall – treat wall + Earth as an infinite mass). In such a case, the "system" approach would say momentum isn't conserved for the ball alone (external impulse from wall), so you handle it via impulse or e on the ball.

6. **Check results and extremes:** After solving, verify the results make sense. Do heavier objects have smaller velocity change than lighter ones? Does the direction of each object's velocity after make sense (e.g., for a head-on collision, one might reverse direction; if you got a result that they both continue forward, double-check if that's possible physically with the given e). If $e = 1$ and masses are equal and one was at rest, they should swap velocities (classic Newton's cradle outcome). If $e = 0$ and they stick, check that momentum was distributed properly. Use the center-of-mass velocity consistency check mentioned earlier: it should remain the same. If something seems off (like you got a final speed higher than initial speed in an inelastic collision – that would violate energy, which usually indicates an algebra mistake or interpreting e incorrectly), revisit your equations.

7. **Apply angular momentum conservation when rotation is involved:** If dealing with a rotational collision (like a lump hitting a rod causing rotation, or two disks merging), modify the above steps: write angular momentum conservation about the appropriate axis. For example, a clay sticking to a rotating disk: no external torque about disk center during impact, so $m_{\text{clay}} v r = (I_{\text{disk}} + m_{\text{clay}} r^2)\omega_{\text{after}}$. Solve for ω_{after}. If both had initial rotation, sum their $I\omega$. This is analogous to linear momentum conservation but in angle form.

   The logic remains: pick system (disk + clay), no external torque about center, so $H_{\text{before}} = H_{\text{after}}$. Solve for ω_{after}. Check limits: if the clay mass is small, it won't slow the disk much; if it's huge, it will slow it a lot – your formula should reflect that.

8. **Energy consideration (just as a check, not for solving):** Once you have final velocities, you might consider qualitatively what happened to kinetic energy. If the collision is inelastic ($e < 1$), kinetic energy after will be less than before – the difference went into heat, deformation, sound. If you accidentally got a scenario where kinetic energy increased (that's impossible unless an explosion or input energy occurred), something's wrong. The exam may not ask for energy, but checking it can alert you to a mistake. In perfectly elastic cases, you could check that kinetic energy is conserved as a secondary confirmation. However, do not use energy conservation to solve unless explicitly dealing with an elastic collision and you find it easier than using e. Usually, using e and momentum is straightforward enough.

By relying on momentum conservation in the right contexts, you sidestep the ugly details of forces during collisions. The key takeaway: **when the problem screams "collision!" think momentum.** Identify if it's linear or angular momentum that's conserved (sometimes both in different aspects). Write a clean before-and-after equation, solve, and you're done. This approach is not only faster under exam pressure but also less prone to mystery errors, since it's rooted in an inviolable law (momentum conservation) that only fails if you include or exclude forces incorrectly. Practice a few collision problems, and you'll start seeing through to the answer with confidence on exam day.

Topic 11 - Free and Forced Vibrations

This topic covers the fundamentals of **mechanical vibrations** for a single degree-of-freedom (SDOF) system, focusing on both **free vibrations** (no external forces) and **forced vibrations** under harmonic excitation. Mastering these concepts is crucial for the FE Mechanical Exam because questions often ask you to determine natural frequencies, damping characteristics, or steady-state vibration amplitudes. The typical question archetypes include computing the system's natural frequency (how fast it oscillates on its own), classifying the damping regime (under/critical/overdamped) from given parameters, or finding the response amplitude under a periodic force (and recognizing resonance conditions). Vibrations problems are common in machine design and dynamics, so being comfortable with these principles helps solve exam questions efficiently.

K07.T11.S01 – Free Vibration of SDOF Systems (Natural Frequency)

Principle Introduction: In an undamped SDOF system (mass m attached to spring k, no damper), if displaced and released it will oscillate at its **natural frequency**. This natural frequency is an inherent property of the mass-spring system:

- The **undamped natural circular frequency** (ω_n) is determined by the stiffness and mass: a stiffer spring or a lighter mass leads to a higher ω_n, meaning faster oscillations, while a soft spring or heavy mass gives a lower ω_n (slower oscillation).

- With no damping, the system conserves energy, so it will vibrate indefinitely at ω_n with constant amplitude (this is an idealization; real systems always have some damping).

- If a viscous damper is added (damping ratio $\zeta > 0$), the oscillation frequency in free vibration becomes slightly lower than ω_n. The system still has an inherent frequency of oscillation (called the **damped natural frequency** ω_d), but due to damping it oscillates at $\omega_d = \omega_n\sqrt{(1-\zeta^2)}$ and gradually loses amplitude over time.

- Natural frequency is crucial on exam day: many vibration problems boil down to plugging in m and k into $\omega_n = \sqrt{(k/m)}$. Keep units consistent (SI: N/m for k, kg for m yields ω_n in rad/s). If asked for frequency in Hertz (cycles per second), you can convert using $f_n = \omega_n/(2\pi)$.

Exam Handbook Search Cues (Not affiliated with or endorsed by NCEES): *natural frequency, undamped vibration, ω_n, single degree of freedom*. (These keywords in the exam reference will point you to formulas and context for SDOF free vibrations.)

Footnotes: Remember that ω_n (omega_n) is an angular frequency (units of rad/s) not cycles/s; if a problem asks for frequency in Hz, convert by dividing ω_n by 2π. [^1]

Also note that m in the formula is mass (e.g. in kg or slug), not weight; if a problem gives a weight (force), you must convert it to mass before using $\omega_n = \sqrt{(k/m)}$. [^2]

Variations and Related Forms: The formula for natural frequency has analogous forms in other domains. For example, a rotational (torsional) vibration system has $\omega_n = \sqrt{(k_t / I)}$, where k_t is torsional spring constant (e.g. N·m/rad) and I is rotational inertia (kg·m²). In all cases, $\omega_n = \sqrt{(\text{stiffness/inertia})}$. Also, sometimes the exam may provide the natural period $T_n = 2\pi/\omega_n$ (time for one oscillation) as an intermediate step.

Special Notes: Typing $\omega_n = \sqrt{(k/m)}$ into your FE-approved calculator is straightforward: enter k, divide by m, then use the square root key. Just be mindful of unit consistency (especially if k is given in unusual units or if using US customary units where mass might be in slugs).

Explanation & Analysis (Step-by-Step): The natural frequency is basically how quickly a system oscillates on its own when disturbed. To derive it, set up Newton's second law for the mass: $F = ma$. For a free vibration with no damping, the only force is the spring: $F_{\text{spring}} = -kx$. So the equation of motion is $m\ddot{x} + kx = 0$. This is a simple harmonic oscillator equation. The solution is sinusoidal: $x(t) = A\cos(\omega_n t) + B\sin(\omega_n t)$, which implies (by substituting into the ODE) that $\omega_n^2 = \frac{k}{m}$. Each term in $\omega_n = \sqrt{\frac{k}{m}}$ has a clear physical meaning:

- **k** – spring stiffness (N/m). A larger k means the spring pushes back harder, so the mass accelerates faster and completes cycles quicker (higher ω_n).
- **m** – mass (kg). A larger m has more inertia, so it oscillates slower (lower ω_n).
- ω_n – angular natural frequency (rad/s). This is not directly "cycles per second" but related: if ω_n = 10 rad/s, that's about 10/(2π) ≈ 1.59 Hz. Always clarify whether the problem expects an answer in rad/s or Hz.

Limit checks: If the spring were extremely soft (k → 0), $\omega_n \to 0$ – the system barely oscillates (essentially no restoring force). If the mass is extremely large (m → ∞), $\omega_n \to 0$ as well – an extremely heavy mass hardly moves. Both make intuitive sense.

Use vs. sibling equations: Use $\omega_n = \sqrt{(k/m)}$ for any undamped SDOF system (free vibration). Don't confuse ω_n with the **forced** vibration frequency of an external input – ω_n is a property of the system itself.

Common exam traps:

- Mixing units (e.g., using k in N/m with m in lbm – convert mass to the proper unit system or use consistent units).

- Reporting frequency in the wrong units (giving ω_n in rad/s when the question wanted Hz, or vice versa).

- Confusing natural frequency with angular frequency in the equation of motion: e.g., writing $m\ddot{x} + kx = 0$solution as $\cos\left(\frac{k}{m}t\right)$by mistake – remember it's $\omega_n^2 = \frac{k}{m}$, not $\omega_n = \frac{k}{m}$.

Footnotes:

[^1]: 1 Hz = 1 cycle per second = 2π rad/s. If ω_n = 20 rad/s, then f_n = 20/(2π) ≈ 3.18 Hz.

[^2]: In US customary units, weight in lbf can be converted to mass in slugs by dividing by g (32.174 ft/s²). For example, a 10 lbf

weight corresponds to m ≈ 0.31 slugs (since F = m·a, 10 = m·32.174). Always use mass in the formula ω_n = √(k/m).

K07.T11.S02 – Damped Vibration Cases (Damping Ratio & Response Types)

Principle Introduction: Real systems always have some damping – friction, air resistance, material hysteresis, etc. Damping causes free vibrations to decay over time. The key parameter is the **damping ratio (ζ)**, which compares the actual damping to the critical amount needed to just prevent oscillation:

- The **damping ratio ζ** is a dimensionless measure: ζ = c / c_{cr}, where c is the system's damping coefficient (N·s/m in SI) and c_{cr} is the **critical damping coefficient**. Critical damping (ζ = 1) is the threshold at which the system stops oscillating altogether; it returns to equilibrium as quickly as possible without overshooting.

- **Underdamped (ζ < 1):** Damping is low relative to critical. The system will oscillate, but with gradually decreasing amplitude. Most practical mechanical systems fall in this category (e.g. a car's suspension typically has ζ ~0.2–0.5, so it oscillates a bit after a bump but the oscillations die out).

- **Critically damped (ζ = 1):** Just enough damping to return to equilibrium **without oscillation** and in the minimum time. The system does not overshoot past the equilibrium point. Any less damping and it would oscillate; anymore and it would still not oscillate but would return slower.

- **Overdamped (ζ > 1):** Damping exceeds critical. The system returns to equilibrium without oscillating, but slower than in the critical case (because excessive damping drags out the motion). Two distinct exponential decay modes occur, both very slow if damping is very high.

- The damping ratio concept matters for classification: exam questions may directly give ζ or ask you to compute ζ from c, m, and k, then identify the response type. Recognize that ζ only depends on system parameters (c, m, k) and not on initial conditions.

Exam Handbook Search Cues (Not affiliated with or endorsed by NCEES): *damping ratio, critical damping, underdamped response, overdamped*. (Using these terms in the exam reference PDF will locate the definitions and relationships for ζ and the different damping cases.)

Footnotes: The **critical damping coefficient** c_{cr} is given by c_{cr} = 2√(k m) for a mass–spring system[^3]. It represents the exact damping value that yields ζ = 1. Also, be aware that some texts use different symbols (for example, some use "b" or "γ" for damping coefficient); on the FE exam reference, **c** is used for damping coefficient and **ζ** (zeta) for damping ratio. Finally, a small damping ratio is sometimes reported as a percentage – e.g., "5% damping" means ζ = 0.05 (dimensionless)[^4].

Variations and Related Forms: For underdamped systems (ζ < 1), the oscillation frequency under damping is $\omega_d = \omega_n$ **√(1 – ζ²)**. This is called the damped natural frequency. It's slightly less than the undamped ω_n (for example, if ζ = 0.1, then ω_d is about 99% of ω_n; if ζ = 0.5, ω_d is about 87% of ω_n). At critical or overdamping, the notion of ω_d (oscillation) no longer applies since there is no oscillation. Instead, the solution for ζ ≥ 1 is characterized by exponential decays: for ζ = 1, x(t) decays roughly like t·$e^{-\omega_n t}$; for ζ > 1, x(t) is a combination of two exponentials with different decay rates. Another related concept is the **logarithmic decrement**, which is a measure of how successive vibration peaks decrease for ζ < 1 – this is more of a mechanical vibrations concept and might be mentioned, but the FE exam usually sticks to ζ itself.

Special Notes: If you need to compute ζ on the exam, it may be easier to first find c_{cr} and then take the ratio. For example, given m and k, find ω_n = √(k/m), then c_{cr} = 2 m ω_n. Compare the given c to c_{cr} to get ζ. The FE-approved calculators handle this fine, but track significant figures and unit conversions. If using U.S. customary units, ensure c is in consistent units (e.g. lbf·s/ft) with k (lbf/ft) and m (slugs) when computing c_{cr}.

Explanation & Analysis (Step-by-Step): The damping ratio ζ quantifies damping in a convenient way. It comes from the standard form of the equation of motion: $m\ddot{x} + c\dot{x} + kx = 0$ can be rewritten as $\ddot{x} + 2\zeta\omega_n\dot{x} + \omega_n^2 x = 0$ (by defining $\zeta = \frac{c}{2m\omega_n}$).

From this form:

- If ζ < 1, the characteristic equation has complex conjugate roots: –ζ ω_n ± i ω_n√(1–ζ²). This yields an oscillatory solution: x(t) = $e^{-\zeta\,\omega_n t}$[C₁ cos(ω_d t) + C₂ sin(ω_d t)], hence oscillation at ω_d with an envelope decaying at rate ζ ω_n. For example, with ζ = 0.2 (20% damping), the amplitude decays relatively slowly – after one period (t ≈ 2π/ω_n), amplitude might still be ~$e^{-0.2\cdot 2\pi}$ ≈ 60% of initial.

- If ζ = 1, the characteristic equation has a repeated real root: –ω_n (a double root). Solution is non-oscillatory: x(t) = (C₁ + C₂ t) $e^{-\omega_n t}$. This decays faster initially than any underdamped case (no time lost to completing a cycle), but it approaches zero asymptotically. It is the borderline case between oscillation and no oscillation.

- If ζ > 1, there are two distinct negative real roots: –ζ ω_n ± ω_n√(ζ²–1). Both exponents are negative, so x(t) = C₁ $e^{r_1 t}$ + C₂ $e^{r_2 t}$ (with r₁ and r₂ negative). No oscillation occurs; the slower root (with smaller magnitude) dominates long-term, meaning the approach to zero can be quite slow if ζ is significantly above 1.

Each term in ζ = c / (2$\sqrt{k\,m}$) is meaningful:

- **c** – damping coefficient (N·s/m). Physically, if the mass moves at 1 m/s, c is the resistive force in newtons. Higher c means more energy lost per oscillation, so heavier damping.
- **2$\sqrt{k\,m}$** – this combination is the critical damping coefficient c_{cr}. Notice it increases with m (a heavier system needs more damping to control) and with k (a stiffer spring pushes back harder, needing more damping to critically damp).

Limit cases: If c = 0, ζ = 0 (no damping, purely oscillatory). If c = c_{cr}, ζ = 1 (critical damping). If c is extremely large (≫ c_{cr}), ζ ≫ 1 (strong overdamping, motion is very sluggish).

Use vs. sibling equations: Use the damping ratio to quickly determine the nature of the transient response. For instance, if a question provides c, m, k and asks what type of response occurs, compute ζ. If ζ is below 1, expect oscillation in the free response; if ζ ≥ 1, no oscillation. This is often faster than solving the differential equation directly.

Common exam traps:

- Forgetting that ζ is dimensionless. Make sure c, m, and k are in a consistent set of units when computing ζ.

- Confusing ζ with the percent of critical damping directly. For example, ζ = 0.1 means 10% of critical damping, not 0.1% or some other interpretation.

- Interpreting an underdamped system as overdamped or vice versa. Sometimes a problem might give initial response descriptions ("oscillates with decaying amplitude") and expect you to identify $\zeta < 1$. Or they might give numerical ζ and ask the behavior – just remember ζ relative to 1 is the key.

- Using the wrong formula for c_{cr}: e.g. using $c_{cr} = 2$ k m (incorrect) instead of $2\sqrt{(k\ m)}$. (Dimensional analysis can help: c has units N·s/m; $2\sqrt{(k\ m)}$ yields N·s/m as well, whereas 2 k m would have different units.)

Footnotes:

[^3]: This formula comes from setting $\zeta = 1$ in $\zeta = c/(2\ m\ \omega_n)$ and substituting $\omega_n = \sqrt{(k/m)}$. It yields $c_{cr} = 2\ m\ \sqrt{(k/m)} = 2\ \sqrt{(k\ m)}$.

[^4]: For example, "$\zeta = 5\%$" in a problem means $\zeta = 0.05$ in your calculations. This could be given directly or indirectly (e.g., "damping is 5% of critical").

K07.T11.S03 – Forced Harmonic Vibration (Resonance & Steady-State Response)

Principle Introduction: Many mechanical systems are subject to **periodic forcing** – for instance, an engine causes vibrations in a vehicle, or an imbalance in a rotating machine creates a sinusoidal force. For analysis, we often model these as a sinusoidal excitation $F(t) = F_0 \sin(\omega t)$ applied to an SDOF system. The interest is in the **steady-state vibration response** (after initial transients die out):

- Under a harmonic force of frequency ω, the system will eventually oscillate at that same forcing frequency (not at its natural frequency, unless the two coincide). The steady-state amplitude can be much larger than the static deflection (F_0/k) if ω is near the system's natural frequency – this is the phenomenon of **resonance**.

- **Resonance** occurs when the forcing frequency matches or is close to the natural frequency ($\omega \approx \omega_n$). In the ideal undamped case ($\zeta = 0$), resonance would cause the amplitude to grow without bound theoretically. In practical damped systems, the amplitude peaks at some finite value when ω is near ω_n. The lower the damping, the higher and sharper this resonance peak.
- The amplitude of steady-state motion is given by a **frequency response function**. It depends on the difference between stiffness and inertia forces and the damping. At low forcing frequencies ($\omega \ll \omega_n$), the mass moves quasi-statically with the force (amplitude ~ F_0/k). At very high frequencies ($\omega \gg \omega_n$), the mass hardly moves at all (amplitude → 0) because the inertia is too large to respond to rapid forces.

- **Amplitude magnification** (also called dynamic magnification factor) is the ratio of the vibration amplitude to the static deflection under the same force. At resonance, this magnification is maximum. Engineers use this to design systems: either shift natural frequencies away from expected forcing frequencies, or add damping to reduce the magnification.

- This topic is important for the FE exam to understand concepts like "what happens if a machine operates at its natural frequency?" or "how does damping affect the forced response?". You might be asked to compute the steady-state amplitude or identify conditions for resonance.

Exam Handbook Search Cues (Not affiliated with or endorsed by NCEES): *forced vibration, resonance, steady-state amplitude, dynamic magnification*. (These terms will help locate the formulas for forced response and the concept of resonance in the exam reference.)

Footnotes: Note that the **resonant frequency** in a damped system is slightly different from ω_n. The maximum amplitude actually occurs at $\omega \approx \omega_n \sqrt{(1 - 2\zeta^2)}$ for a lightly damped system [^5]. For small ζ, this is almost equal to ω_n, so on the exam it's usually acceptable to treat resonance as "around ω_n". Also, be cautious with terminology: "natural frequency" refers to the system's own frequency (ω_n), while "driving frequency" or "forcing frequency" is the frequency of the external force (ω). Resonance is when those two line up. Lastly, ensure you input frequencies correctly – if a problem gives a rotation speed in RPM or frequency in Hz, convert it to ω in rad/s before using these formulas [^6].

Variations and Related Forms: The standard formula for steady-state amplitude (see below) can be rearranged or expressed in terms of frequency ratio $r = \omega/\omega_n$. Sometimes problems give the amplitude ratio directly or ask qualitatively what happens as ω varies. The concept of **phase angle** is also related – the steady-state vibration will lag behind the force by a phase $\varphi = \arctan$

$$\frac{2\zeta(\omega/\omega_n)}{1-(\omega/\omega_n)^2}$$

. At resonance, this phase is 90° (the displacement lags force by a quarter cycle). While phase is less commonly asked on the FE, understanding that below resonance the mass moves in-phase with force (small lag) and above resonance it moves out-of-phase (almost 180° lag) can help with conceptual questions. Another related concept is **transmissibility** if the forcing is applied to the base (like a vibrating foundation), but that is typically a specialized case of forced vibration formula (not likely needed beyond understanding that isolation improves when operating above resonance with damping).

Special Notes: When using the steady-state amplitude formula on the calculator, break it into pieces to avoid mistakes. Calculate the denominator in parts: compute $(k - m\omega^2)$ and $c\,\omega$ separately, then square them, sum, and take the square root, then do F_0 divided by that result. It's easy to make algebra mistakes if you try to do it all at once. If the problem gives F_0 as a sinusoidal force amplitude, use it directly. If instead a rotating imbalance is described (mass spinning causing vibration), the effective forcing F_0 might be $m_e * r * \omega^2$ (where m_e is imbalance mass, r is offset radius), but the exam will likely either avoid that or give you the equivalent F_0. Always confirm units: F_0 in newtons, k in N/m, m in kg, c in N·s/m, ω in rad/s, so that the computed X comes out in meters.

Explanation & Analysis (Step-by-Step): The steady-state response amplitude X for the equation $m\cdot\ddot{x} + c\cdot\dot{x} + k\cdot x = F_0 \sin(\omega t)$ is given by:

$$X = \frac{F_0}{\sqrt{(k-m\omega^2)^2 + (c\omega)^2}}.$$

This formula comes from solving the particular solution of the ODE (or from the frequency response function of a second-order system). Let's break down the pieces:

- The term **$(k - m\,\omega^2)$** represents the difference between the spring force needed for static equilibrium and the inertia force at frequency ω. When ω is such that $m\,\omega^2$ is much less than k (low ω), this term is approximately k, and the denominator ≈ k, so $X \approx F_0/k$ (makes sense: at low frequency the mass essentially just statically deflects under the force). When $m\,\omega^2$ is close to k (i.e. $\omega \sim \sqrt{(k/m)} = \omega_n$), this term becomes small – the spring's restoring force nearly cancels the inertial reaction, leaving damping as the only significant opposing force; this is when X becomes large (resonance).

- The term **(c ω)** is the damping force component at frequency ω. When ω is high, c ω can be large, meaning damping is significant in opposing motion (this is why at high speeds the amplitude stays small – damping and inertia dominate). At resonance, if damping is light, c ω is still relatively small compared to the near-zero stiffness–inertia term, so the denominator is small and X spikes. If damping is heavy, c ω is larger, preventing the spike.

- Units check: In the denominator, (k – m ω²) has units of N/m (since k is N/m, and m·ω² also yields N/m when interpreted as equivalent spring force per unit displacement at that frequency). (c ω) has units N·s/m * 1/s = N/m. So each term under the square root is in consistent force-per-displacement units (N/m), squaring them gives (N/m)², summing, then sqrt gives N/m. Finally F_0 (N) divided by that (N/m) gives meters – a correct unit for X. You don't need to carry out this dimensional analysis on the exam, but it reassures that using SI units correctly will yield X in meters.

Resonance insight: At exactly ω = ω_n (for the undamped case), the denominator becomes (k – m ω_n^2) = 0 and c ω term is zero (if c = 0), resulting in X → ∞. With damping, at ω = ω_n the denominator is

$$\sqrt{(k - m\omega_n^2)^2 +} = \sqrt{0^2 + (c)^2} = c\omega_n$$

so X = F_0/(c ω_n). This is large when c is small. For example, if c is 5% of critical (ζ ≈ 0.05), then at resonance X ≈ F_0/(0.05·2 m ω_n * ω_n) = F_0/(0.1 m ω_n^2). Since F_0 = m ω_n^2 (for a unit static deflection scenario), X ≈ 1/0.1 = 10 times the static deflection. This matches the magnification ~10 seen in the figure for ζ = 0.05. Conversely, if ζ is larger, say 0.4, then X at ω_n is F_0/(0.42 m ω_n * ω_n) = F_0/(0.8 m ω_n^2) = 1/0.8 = 1.25 times static – a much milder bump. In fact, for very high damping (ζ ≥ ~0.7), the system doesn't really exhibit a pronounced resonance peak at all (the worst-case amplitude is at ω = 0). Understanding this trend can guide intuition: more damping → lower and broader resonance peak; less damping → higher and sharper peak.

Limit checks: We already considered ω → 0 and ω → ∞ giving X → F_0/k and X → 0, respectively. Another check: if we set F_0 = 0 (no forcing), obviously X = 0, which the formula gives trivially. If we remove damping entirely (c = 0, ζ = 0), the formula reduces to X = F_0/|k – m ω²|. At ω = ω_n in that case, the denominator → 0 and X → ∞ – which is the mathematical expression of undamped resonance. All these align with physical expectations.

Use vs. sibling equations: Use this steady-state amplitude formula for **harmonic (sinusoidal) forcing** of an SDOF system. If the problem is about transient behavior (e.g. free vibration after an impulse or initial displacement), use the homogeneous solution formulas from free vibration instead. If the forcing is not sinusoidal (like a step load or an arbitrary time function), this formula doesn't directly apply (though conceptually you could break a complex input into sinusoidal components – that's beyond FE scope). Also, if dealing with multiple degrees of freedom or vibration modes, the problem usually simplifies to considering one mode at a time or gives you an equivalent SDOF scenario; in such cases, ensure you're applying the formula to the correct equivalent stiffness k and mass m for that mode.

Common exam traps:

- Confusing **ω** (forcing frequency) with ω_n (natural frequency) in the formula. Make sure you plug the correct value for each. For example, if a problem states a machine operates at 1200 rpm and the system has a natural frequency of 20 Hz, convert 1200 rpm to ω = 125.7 rad/s and ω_n = 20×2π = 125.7 rad/s – interestingly, that means it's exactly at resonance.

- Not converting units of frequency: RPM to rad/s, or Hz to rad/s, before plugging into formulas. The formula expects ω in rad/s. A common mistake is to plug f (Hz) where ω is needed, which underestimates the effect (since ω = 2πf).

- Algebra mistakes under the square root. For instance, forgetting to square the (c ω) term or the (k – m ω²) term. The entire denominator is under the square root, with each component squared before summing. It can help to write intermediate values: e.g., compute Δ = k – m ω², then compute Δ² and (c ω) ², sum and sqrt.

- Using the formula for the wrong situation: e.g., trying to apply it to a non-harmonic force or to a quantity other than displacement (the formula as given solves for displacement amplitude X; if the question asks for velocity amplitude, you'd multiply X by ω, etc.). Make sure you know what you're solving for.

- If a question asks conceptually about the effect of damping or frequency, avoid extreme interpretations. For instance, "if damping is doubled, what happens to resonance amplitude?" – it won't double; in fact, higher damping *reduces* amplitude. Or "if forcing frequency is slightly below ω_n, what's the phase?" – expect something less than 90° lag (mass lagging force). Keeping the qualitative picture from the figure in mind will help answer such questions correctly.

[^5]: The frequency at which the amplitude is maximum is obtained by differentiating the magnification factor with respect to ω. The result is $\omega_{peak} = \omega_n \sqrt{(1 - 2\zeta^2)}$ for ζ < 1/√2 (~0.707). For heavier damping (ζ ≥ 0.707), the amplitude simply decreases monotonically with increasing ω, so the largest amplitude is actually at ω = 0 (static deflection).

[^6]: Example of conversion: 1800 rpm = 1800/60 = 30 Hz = 2π × 30 ≈ 188.5 rad/s. If ω_n = 200 rad/s, then r = ω/ω_n ≈ 0.942. Always use ω (rad/s) in the formulas, not rpm or Hz directly.

DON'T MOVE ON YET!

Work Through Some Solid Practice Problems
while the Material of this Knowledge Is Still Fresh
THIS IS HOW THE CONCEPTS LOCK IN.

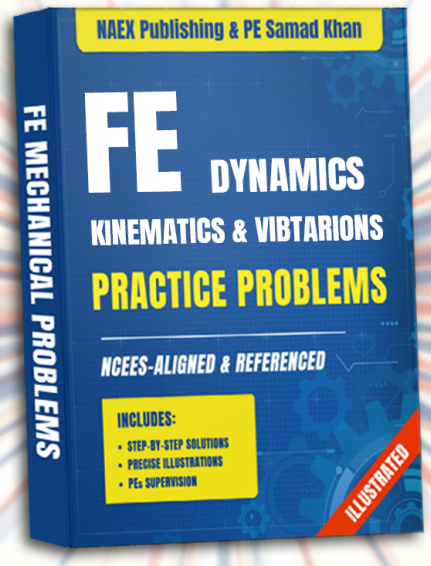

CLICK HERE TO PRACTICE

You'll be taken to our Discord Server, where the problems are located.

KNOWLEDGE 08

MECHANICS OF MATERIALS

- NAEX Publishing -

"This publication is not affiliated with or endorsed by NCEES".

Topic 01 - Shear and Moment Diagrams

Topic Overview: In beam problems, internal shear forces (V) and bending moments (M) tell us how loads are carried between supports. **Shear and moment diagrams** graphically plot these internal forces along the length of a beam. On the **FE Mechanical Exam**, you'll often face questions about beams with loads – for example, finding the bending moment at a certain point or the maximum stress in a beam. Drawing shear/moment diagrams (even a quick sketch) helps solve these by visualizing how V and M vary. This topic matters because it connects the external loads to internal stresses: mastering it means you can quickly check beam safety and deflections, and avoid sign errors on exam day. Typical question archetypes include *"Given a loaded beam, what is the internal moment or shear at a specific location?"* or *"Where does the maximum bending stress occur?"* Understanding shear and moment diagrams is the key to answer these confidently and avoid confusion with sign conventions or integration errors under time pressure.

K08.T01.S01 – Sign Conventions for Internal Shear Forces and Bending Moments

Principle Introduction:

- **Internal forces in beams:** When you cut through a loaded beam, the internal shear force (V) and bending moment (M) are the reactions holding the beam together at that section. Sign conventions tell us which direction of these internal forces we treat as positive.
- **Standard positive directions:** For the FE exam (and most engineering texts), a **positive bending moment** curves the beam **concave up** – imagine the beam sagging into a gentle "smile" shape (tension at the bottom, compression at the top). A **positive shear force** makes the **right side of the cut drop downward relative to the left side**. In practice, that means if you slice the beam, the internal shear on the left face of the cut acts upward, and on the right face acts downward (keeping equilibrium).
- **Why conventions matter:** Consistent signs ensure that the beam equilibrium equations and formulas (like $dM/dx = V$) work correctly. Using the wrong sign convention can lead to errors (like getting a moment diagram upside-down or a wrong failure prediction). Fortunately, the FE exam will either assume the standard conventions or state otherwise. Your job is to stick with the standard unless told different.
- **Positive vs. negative effects:** With this convention, a **positive** M causes a sagging deformation (think of a simply supported beam with a downward load producing a smile-shaped curve). A **negative** M does the opposite (beam bends into a frown shape, tension in top fibers). Likewise, a **positive** V at a section means the beam segment to the left pushes upward on the segment to the right, while a **negative** V would push downward on the right segment. These definitions help you quickly interpret diagram results: e.g. if you find M to be negative in a region, you know the beam is bending the other way (possibly important if a certain side of the beam has a crack or yield point).

Exam Handbook Search Cues (Not affiliated with or endorsed by NCEES): *shearing force*, *bending moment*, *sign convention*, *concave upward* (to find standard sign conventions in the exam reference). These keywords point you to the official definitions of positive V and M as used in the exam handbook. Always verify you're using the correct sign convention during the exam if a problem seems off.

Footnotes:

- *Units:* Internal shear V is a force (units: N in SI or lb in USCS) and bending moment M is a moment (units: N·m or lb·ft). In diagrams, we typically plot V in kN or lb and M in kN·m or ft·lb to keep numbers manageable. Ensure consistent units when interpreting diagram values (e.g. don't mix up ft·lb with in·lb).
- *Sign clarity:* Different textbooks may use different sign conventions (some define positive moment as causing compression in bottom fibers instead). **For the FE Mechanical Exam, use the convention described here** (concave up = positive M, right side down = positive V) unless a problem specifically states otherwise. This will align with the exam handbook usage and prevent sign reversals.
- *Load sign:* By common convention, downward distributed loads are taken as positive $w(x)$ (since they produce a positive *clockwise* shear change on the right side). This is consistent with the negative sign in $dV/dx = -w$ (a downward w makes shear V decrease to the right). If you take upward loads as positive instead, you'd need to flip the signs in the relations – so stick to the standard to avoid confusion.

Variations and Related Concepts: The sign convention provides a mental check for beam deflections. For example, a beam under uniform gravity load will sag (concave up) – confirming the bending moment is positive under that load if we follow this convention. If you ever get a moment diagram that indicates a frown shape for a simple gravity-loaded beam, you've likely got a sign inverted. Remember that internal **shear V is related to shear stress** (via $\tau = VQ/It$ in materials formulas) – the sign (positive/negative) of V in a diagram doesn't change the magnitude of shear stress computation (since shear stress is typically taken as positive magnitude), but it does indicate direction of internal force (important if combining effects or evaluating beam sections for upward vs. downward shearing action). **Alternate conventions** (like defining positive moment as concave down) exist, but you won't need them on the FE; just know they exist so you won't be thrown off if you encounter them outside the exam context.

Special notes: There is not much to "calculate" directly with sign conventions, but it's a foundation for using formulas. When using your calculator for beam problems, the sign convention comes into play in setting up equilibrium equations or when plugging into formulas like $M = \frac{EI}{\rho}$ (curvature) or $v = \frac{VQ}{It}$ (shear stress). **Tip:** Draw a quick sketch marking positive V and M on a cut (like the figure above) on your scratch paper if you're unsure about a sign while solving a problem. This 5-second sketch can save you from sign errors on exam day.

Explanation & Analysis: Sign conventions are basically a bookkeeping system – they keep track of **which way your beam is bending or shearing**. The positive directions chosen (concave-up bending, right-drop shear) are not magic; they're chosen because they make many formulas consistent and intuitive. For instance,

with this convention a positive distributed load (downward) makes the shear diagram slope downward (since $dV/dx = -w$ will be negative), and a positive shear makes the moment diagram slope upward (since $dM/dx = V$ will be positive if V is positive upward). Physically, V **(shear)** at a section represents how the beam's left portion pushes up or down on the right portion. M **(bending moment)** represents how much the beam is bending at that section – positive M tries to make the beam sag. If you imagine standing on a beam that's sagging, the top of the beam is getting squished (compressed) and the bottom stretched – that's positive bending by our sign convention. On the exam, correctly accounting for sign means the difference between getting the correct internal force versus an answer off by a negative sign. A quick micro-check: *If you remove a support from under a beam, will it sag into a smile?* If yes, then the moments in the span were positive (smile shape) under gravity loads. Keep these sign concepts handy; they ensure your shear and moment diagrams and calculations align with the expected directions of deflection and force. It might feel abstract, but once you solve a few problems, you'll "see" the beam smiling or frowning in the moment diagram, and that makes the abstract signs a lot more concrete.

K08.T01.S02 – Differential Relationships: Load $w(x)$, Shear $V(x)$, and Moment $M(x)$

Principle Introduction:

- **Beams as functions:** The distributed load along a beam is a function $w(x)$ (force per length at position x), the internal shear is $V(x)$, and bending moment $M(x)$. These aren't independent – they are mathematically related. If you know one, you can get the others by calculus (differentiation or integration).
- **Key differential equations: Shear is the slope of the moment diagram**, and **load is (minus) the slope of the shear diagram**. In formula form: $\frac{dM(x)}{dx} = V(x)$ and $\frac{dV(x)}{dx} = -w(x)$. These two equations underpin how we construct shear/moment diagrams from loads. They come straight from equilibrium of an infinitesimal beam slice.
- **Meaning of the relationships:** $dM/dx = V$ means if you move a tiny bit along the beam, the change in bending moment equals the internal shear force there (in consistent units). Intuitively, **shear is the derivative of moment** – so wherever shear is zero, the moment is at an extremum (peak or valley) because the slope dM/dx is zero. And $dV/dx = -w$ means the shear *decreases* in the direction of positive x whenever there's a positive (downward) distributed load. If there's no distributed load on a segment ($w = 0$), then $dV/dx = 0$ so shear is constant on that segment (horizontal line on the shear diagram).
- **Integral form (area method):** The same relationships can be expressed integrally: $V(x_2) - V(x_1) = -\int_{x_1}^{x_2} w(x)\,dx$ and $M(x_2) - M(x_1) = \int_{x_1}^{x_2} V(x)\,dx$. In words: *the area under the load curve gives the change in shear*, and *the area under the shear curve gives the change in moment*. This is extremely useful for diagram construction – it means the shear diagram's area corresponds to how much moment increases or decreases.
- **Using these on the FE Exam:** These differential relationships are listed in the exam reference handbook (usually right next to the sign convention). They are your go-to formulas for quickly building shear or moment diagrams without doing full equilibrium at every cut. For instance, if you have a uniform load w_0 over a span, you know immediately that $V(x)$ will be a linear function (slope = $-w_0$) and $M(x)$ will be a quadratic (since slope of M is linear V). If you have just a point load, you know $w(x) = 0$ everywhere except a point, so shear is constant between loads and moment is linear between those points. Keeping these relations in mind will speed you up and reduce mistakes. They also help check your work: if you draw a moment diagram, you can differentiate it (slope at points) to see if it matches your shear diagram; any inconsistency means something's wrong.

Equation and Key Relations:

Name and purpose: *Load–Shear–Moment Relationships* – These equations relate the distributed load intensity, the internal shear force, and the bending moment in a beam. They allow you to move from load to shear to moment (or reverse) by differentiation or integration, instead of doing repeated static equilibrium calculations for every segment. Use them to construct diagrams quickly or to verify your results (e.g. check that the slope of your moment diagram equals the shear value you found).

Equations:

$$\frac{dV(x)}{dx} = -w(x), \qquad \frac{dM(x)}{dx} = V(x)$$

Variables and units:

- $w(x)$ – Distributed load as a function of position x along the beam (units: N/m or lb/ft). By convention here, $w(x) > 0$ means a load directed downward on the beam.
- $V(x)$ – Internal shear force at position x (units: N or lb). Positive V follows the sign convention from S01 (upward on the left face of a cut).
- $M(x)$ – Internal bending moment at position x (units: N·m or lb·ft). Positive M causes concave-up bending (sagging).
- x – Position coordinate along the beam (units: m or ft, consistent with the units of w so that the calculus works out: e.g. N/m integrated over m gives N = shear; N integrated over m gives N·m = moment).

Assumptions and scope:

- These relationships assume a **static, slender beam** with loads applied transversely (no significant axial loads or dynamic effects). They come from static equilibrium of an infinitesimal beam element, assuming the beam is prismatic (constant cross-section) and material is continuous (so $V(x)$ and $M(x)$ are differentiable between load points).
- Valid **between concentrated forces or moments**: The formulas hold in regions where $w(x)$ is defined as a continuous load distribution. At a point load or applied couple, $w(x)$ is not defined (it's like an impulse), and V or M will have a discontinuity there. In those cases, use the integral form with a jump: e.g., a concentrated downward force P at a point causes an abrupt drop $\Delta V = -P$ in shear; a concentrated moment M_0 causes an abrupt jump $\Delta M = +M_0$ in the moment diagram. We typically handle those separately (see subtopic S03).
- The sign convention from S01 is assumed: downward w makes V decrease, and positive V makes M increase to

the right. If you were (hypothetically) using an opposite convention, the equations' signs would change accordingly. For the FE exam, stick to these forms.

- **Out of scope:** These beam formulas do *not* directly apply to scenarios with distributed *moments* or varying axial loads – those are more advanced cases. Also, they assume small deflections (so geometry doesn't change under load). The FE exam won't require dealing with non-standard cases like variable axial force coupling or very large deflections for shear/moment calculation.

Limit checks (sanity tests):

- If there is **no distributed load** over a region ($w(x) = 0$), then $\frac{dV}{dx} = 0$. This implies V is constant in that region – on the shear diagram you'd draw a flat horizontal line. Correspondingly, $\frac{dM}{dx} = V$ would be constant, so M changes linearly (straight line segment on the moment diagram). This matches what we expect: no load in a span means shear doesn't change, and bending moment just ramps up or down linearly.
- If there is **no shear** at some point ($V = 0$), then $\frac{dM}{dx} = 0$ at that point – meaning the moment diagram has zero slope (a peak or trough there). This is a crucial insight: where the shear crosses zero, the moment reaches a local extremum (often a maximum bending moment). This helps in design (maximum stress from max moment) and is a quick check on diagrams (shear graph crossing zero should align with moment graph's peak).
- If the **distributed load is intense** (very large w), $\frac{dV}{dx}$ is very large in magnitude – the shear diagram will slope very steeply downward. Imagine an extremely heavy load on a small segment; the shear force plummets as you go into that loaded segment. Similarly, a large shear means a very steep moment slope. These extremes make sense: heavier loads cause quicker changes in internal force.
- As $w \to 0$, we approach the case of no load (discussed above). As $V \to 0$, we approach an internal moment extremum. There's no scenario of $M \to \infty$ in a real beam for static loads (the beam would fail before that), but mathematically if you integrate a nonzero shear over a long distance, M accumulates – which is why long spans under load see high moments near the supports.

Use vs. sibling methods: Use these differential relationships *instead of laborious section-cut equilibrium at every point.* In classic statics, one might cut the beam at distance x and solve V and M by setting $\sum F_y = 0$ and $\sum M = 0$. These formulas shortcut that process: $\frac{dV}{dx} = -w$ is essentially $\sum F_y$ for a tiny slice, and $\frac{dM}{dx} = V$ comes from $\sum M = 0$ for that slice. So, rather than re-deriving equilibrium for each segment, you integrate w to get V and integrate V to get M. This is especially powerful for piecewise uniform loads. **Use these equations when sketching shear/moment diagrams or when checking if your diagrams are consistent.** (Another "sibling" concept is the area method: the area under the shear diagram between two points gives the change in moment – this is just the integral form of the second equation.) There's really no alternative formula for these relations – they are fundamental. Just be careful: don't confuse these with unrelated formulas like stress or deflection equations; they strictly tie load, shear, and moment.

Common exam traps:

- *Missing the negative sign:* It's easy to forget that $\frac{dV}{dx} = -w(x)$ has a negative. Students sometimes mistakenly use $dV/dx = +w$, which is wrong given our sign convention. Remember: a positive (downward) load makes the shear go *downhill* as you move right. A quick fix if you're unsure: imagine a simply supported beam with a uniform downward load – the shear starts positive at left support and ends negative at right support, a downward slope, confirming the negative sign.
- *Misidentifying zero points:* Another pitfall is forgetting that where $V = 0$, M is extremal. On a diagram question, if you overlook a zero-crossing of shear, you might miss the location of maximum moment. Always scan for $V = 0$ points – the exam might ask for the maximum moment or require you to evaluate M where $V = 0$.
- *Discontinuities and misuse:* Applying the differential formulas *at* a point load or couple can be misleading. For example, some might try to plug a point load as a delta in $w(x)$ and get confused. Handle those separately: treat each region of continuous $w(x)$ separately, then apply jumps for point loads/couples. If you try to integrate across a discontinuity without accounting for the jump, you'll get the wrong values. In exam problems, always break the beam into segments between concentrated loads before applying these relationships.
- *Unit confusion:* Ensure that when you integrate w to get V, or V to get M, your units carry through properly. If w is given in, say, kN/m, and length in m, then integrating gives kN (for shear). If you're summing areas under a shear curve in kN vs. m, the moment will come out in kN·m. It sounds obvious, but under pressure it's easy to mix up, say, a moment value in lb·ft versus lb·in. The exam may mix unit systems, so keep track (the exam handbook provides unit conversions, but you must apply them correctly). A good practice is to write units in intermediate steps of calculations to catch mistakes early.

Exam Handbook Search Cues (Not affiliated with or endorsed by NCEES): *distributed load*, *shear*, *bending moment*, *dV/dx*, *dM/dx*. Searching these terms in the exam reference PDF will show the section where the above relationships are stated (likely under Mechanics of Materials). The handbook might list them in a concise form. Being familiar with these keywords means you can quickly find the formulas if you blank on them during the exam, but ideally you'll remember the concept by heart: load is the slope of shear (with a negative), shear is the slope of moment.

Footnotes:

- *Sign of w:* We define $w(x)$ as positive downward to match typical loading scenarios (e.g., gravity acting downward is a positive w). This is why a positive w causes a decrease in V (negative slope). If you had a problem where an upward distributed load is applied (less common), you can either plug in a negative w value or remind yourself that it will make V increase. The sign convention choice is arbitrary as long as you're consistent, but the exam will usually stick to downward loads.
- *Use of calculus:* On the FE exam, you won't be asked to derive these formulas, but you **may need to integrate or**

differentiate simple functions (like a constant or linear $w(x)$ or $V(x)$) to get V or M. The calculus involved is basic (integration of polynomials or finding where a derivative is zero). Make sure you're comfortable doing these quickly. For example, if $w(x) = 5$ kN/m on a span of 3 m, then the shear change is $-\int_0^3 5\ dx = -15$ kN (a drop of 15 kN over that span). Or if your shear between two points is given by $V(x) = 10 - 2x$ (kN), the change in moment is $\int V\ dx = 10x - x^2$ (plus constant), so over a certain interval you can find M values. Being fluent in these quick integrations will save time.

- *Relation to deflection:* Interestingly, if you differentiate further ($d^2M/dx^2 = dV/dx$), you get $d^2M/dx^2 = -w$. And recall from strength of materials that $M = EI\kappa$ (where κ is curvature), and for small deflections $\kappa \approx d^2y/dx^2$ (second derivative of deflection). This leads to $EI\ d^2y/dx^2 = M$. Combining, $EI\ d^4y/dx^4 = -w$. That's the beam deflection differential equation (fourth order). It's beyond what you solve directly on the FE (solving that needs boundary conditions and more time), but it's good to know these relationships stack up. It shows consistency: loads relate to deflections through these successive derivatives. The FE might test simpler aspects like knowing $M''^{(x)} = -w/EI$ qualitatively, but not solving the 4th order ODE.
- *Keep it simple:* You don't need to memorize the integral forms separately if you remember the differential ones; just integrate in your head. The main takeaway is: **slope of M is V, slope of V is $-w$**. Write that on your scratch paper if needed during the exam to anchor yourself. It's like a mantra for beam analysis.

Explanation & Analysis: Let's break down the relationship $dV/dx = -w$ and $dM/dx = V$ in plain language. Consider a small segment of beam of length Δx. The difference in shear force between the two ends of this segment, $V(x + \Delta x) - V(x)$, must equal (in the limit) the negative of the load applied over that segment ($-w(x)\ \Delta x$). This is just saying: *if you cut out that tiny piece of beam, the net force from the distributed load on it must be balanced by the change in shear between its ends.* Hence $dV = -w\ dx$. Similarly, the difference in bending moment between the two ends, $M(x + \Delta x) - M(x)$, equals $V(x)\ \Delta x$ (again in the limit) – meaning the internal shear acting over a small distance produces a moment change (think of $V \times$ distance). In short, *shear is the derivative of moment* because shear represents how much moment is accumulating as we move along the beam.

What do each of these terms represent physically? $w(x)$ is straightforward – it's the load intensity (like the weight per length or distributed force per length). If $w(x)$ is high in some region, you're dumping a lot of force into the beam there, so you expect the shear to drop quickly as you pass through that region (hence a steep slope in the V diagram). $V(x)$ is the internal shear force – basically how much of that distributed load (or point loads) to the left of x the beam has "picked up" and is carrying at that section. If $V(x) = 0$, it means the beam to the left of that point carries no net vertical force beyond that point – often a sign of maximum moment or a point of contraflexure (moment changing sign). $M(x)$ is the internal bending moment – it's the cumulative effect of all the loads to the left of x in making the beam bend. If $M(x)$ is large, it means a lot of bending is going on at that section (which often means high stress $\sigma = My/I$ in the beam's material). The relationship $dM/dx = V$ implies that the *steeper* the moment diagram climbs, the higher the shear in that segment. So if you see a moment diagram drawn steeply, you know shear must be large there (and indeed, likely a big load or reaction is nearby to cause that).

On the exam, these relationships are super useful not just for drawing diagrams but also for **quick calculations**: e.g., if asked "what is the bending moment 3 m from the left end of a beam under this triangular load?", you might integrate the load to get shear and integrate again to get moment (or use area of triangle formulas). If asked "where is the moment maximum?", you set $V = 0$ (because $dM/dx = 0$ at extremum). These are faster than solving multiple equilibrium equations for sections. Just remember to apply the proper limits: integration constants come from boundary conditions (like at a free end $V = 0$ or at a support $M = 0$ for a simply supported, etc.). A common mistake is to forget the constant of integration – e.g., integrating $dM/dx = V$ gives $M(x) = \int V\ dx + C$. That constant C is determined by a known moment value (like $M = 0$ at a free end). So if you ever integrate and get a formula for $M(x)$, plug in a point you know M for to solve for C.

In summary, the differential relationships tie the load, shear, and moment together in a nice calculus bow. They ensure consistency: any valid shear diagram and moment diagram must satisfy these slopes. If you have them in mind, you can often double-check your answers: differentiate your moment expression, do you get your shear? Differentiate shear, do you (with a negative) get back the load distribution? These serve as both a tool for solution and a check for correctness – a great dual purpose on an exam where every check can save precious points.

K08.T01.S03 – Construction of Shear and Bending Moment Diagrams for Beams

Principle Introduction:

- **What are shear and moment diagrams?** They are graphical representations showing how internal shear force V and bending moment M vary along a beam's length. To **construct** these diagrams, you systematically apply the relationships from S02 and the effects of different loads (concentrated forces, distributed loads, and moments). The goal is a clear piecewise diagram: the baseline is usually the beam's length on the horizontal axis, with shear and moment values plotted vertically.
- **Why construct them?** On the FE Exam, drawing a full diagram may not always be required (since it's time-consuming), but understanding how to construct one helps you answer specific questions. For example, if a question asks for the moment at a point, you can effectively do a partial moment diagram computation for that point. If it asks where the maximum moment is, you envision or compute enough of the diagram to find the peak. In other words, knowing the construction method trains you to solve any beam internal force problem systematically. Also, occasionally a conceptual question might present a shear or moment diagram and ask you to identify the loading or vice versa – having construction fundamentals will make those questions straightforward.

Types of loads and their diagram "fingerprints":

- A **concentrated load** (point force) on a beam appears as a sudden jump/discontinuity in the shear diagram at that location. The magnitude of the jump in V equals the magnitude of the load (downward load causes a downward jump in the shear diagram). In the moment diagram, a point load does *not* cause a jump; instead it

causes a change in slope (because it changes shear on either side). So you'll see a kink in the moment diagram at that point (the moment line segments have different slopes before vs. after the load).

- A **distributed load** over a span shows up as a sloped portion in the shear diagram (since $dV/dx = -w$). If w is constant (uniform load), the shear diagram will be a straight line with slope $-w$. If w varies (say a triangle load), the shear diagram will be curved (the slope itself changes). In the moment diagram, a uniform w produces a curved (parabolic) segment (since $M''^{(x)} = -w$ constant gives a quadratic $M(x)$). A linear $w(x)$ would produce a cubic $M(x)$ shape, and so on. So distributed loads create smoothly varying diagrams rather than jumps.
- A **couple (concentrated moment)** applied to the beam shows as a sudden jump in the **moment** diagram at that point (of magnitude equal to the applied moment). However, it does *not* affect the shear diagram except possibly right at that point (no jump in shear because a pure moment doesn't exert vertical force). Essentially, a positive applied moment will instantaneously raise the moment diagram (if it's a clockwise couple applied to the beam, consistent with positive sign convention, the moment diagram jumps up). The shear diagram remains continuous (though the slope of moment diagram – the shear – is unchanged just before and after a pure moment application).

- **Overall construction strategy:** The general approach is: **(1)** determine support reactions (so you know boundary values of shear, etc.), **(2)** cut the beam into spans between any applied loads or moments, **(3)** write $V(x)$ expressions by integrating $-w$ over each span (or by simple geometry if w is constant), **(4)** account for jumps at any point loads by adjusting the shear immediately after that point, **(5)** integrate $V(x)$ to get $M(x)$ for each span, **(6)** account for any moment jumps due to applied couples, and **(7)** apply boundary conditions at the supports (e.g. for simply supported, $M = 0$ at both ends; for a free end, $V = 0$ at the end, etc.) to finalize the values. This yields piecewise functions for V and M, which you then sketch as line or curve segments on the diagram, connecting them appropriately.

Exam Handbook Search Cues (Not affiliated with or endorsed by NCEES): While the exam reference handbook provides the formulas for relationships and some definitions, it doesn't give step-by-step diagram construction. Relevant keywords in the handbook might be *shear*, *bending moment*, *beam*, or looking at example problems. However, constructing diagrams is more of a skill you apply rather than look up. Still, knowing terms like "shear force", "bending moment", and "sign conventions" will let you quickly verify any definitions if needed. On exam day, use the handbook for confirmation of a formula or convention, but rely on practiced procedure to actually draw or reason through the diagrams.

Footnotes and Tips:

- *Start with reactions:* Always compute support reactions first for a determinate beam (using static equilibrium $\sum F = 0, \sum M = 0$). The reactions set the starting and ending values of the shear diagram. For instance, in the example above, we immediately set shear at left end equal to the left reaction $P/2$. Missing this step is a common mistake. Remember, the area under $w(x)$ over the entire beam must equal the net change in shear from one end to the other (which is essentially going from 0 at the far left outside the beam to 0 at the far right outside). That's why the reactions – balancing the total load – show up as the initial and final jumps in shear.
- *Sign of jumps:* For a point load, if the load is **downward**, the shear diagram jumps **downward** by that amount as you pass the point. If somehow a load were upward, shear would jump up. For a couple, a **positive clockwise moment** (applied to the beam) causes an **upward jump** in the moment diagram (because our sign convention considers clockwise on left face positive, so an external clockwise couple adds positive moment). If an external counterclockwise moment is applied, it would cause a negative jump (downward) in the moment diagram. Keep these sign effects straight: one way is to think in terms of internal balancing – an external downward force needs the internal shear to drop to carry that extra force; an external clockwise couple needs the internal moment to jump up to carry it.
- *Drawing conventions:* On your scratch paper, it helps to draw the shear and moment diagrams directly below the beam illustration, aligned to the same horizontal scale. Mark key values (peak values, zero crossings) clearly. Use straight lines for regions of zero or constant slope, and smooth curves for parabolic or higher-order segments. On the FE, you might not have to present the diagram, but drawing it accurately will lead you to the right numeric answers. Also, clearly indicate positive and negative regions (above or below the baseline). If you find negative values, it's fine – it just indicates the internal force is opposite to the positive direction (e.g. moment causing concave-down bending).
- *Calculator usage:* Constructing diagrams is mostly analytical/graphical, so your FE-approved calculator might only be used to plug in numbers for calculations (like computing a value of moment at a point, or adding up areas). There's no built-in feature for drawing these diagrams on exam calculators, so it's all about your method. Use the calculator to sum areas or evaluate formulas you derive for $V(x)$ or $M(x)$, especially for non-integer values or awkward distances. For example, if $V(x) = 5 - 2.4x$ (kN) in a segment, you might plug $x = 3.7$ m to get the moment change from 3 m to 3.7 m. But in most cases, the algebra is simple enough to do by hand if you set it up right.
- *Check equilibrium at the end:* After drawing the diagrams, do a quick equilibrium sanity check: The final shear at the rightmost end should return to zero (if you've accounted for all reactions and loads). The final moment at a free end or pinned support should be zero. If the moment diagram doesn't end at zero where it should, you've got a mistake (maybe a missing couple or wrong area under shear). If the shear diagram doesn't end at zero, maybe you mis-calculated a reaction or missed a load. These boundary conditions are non-negotiable for a correct diagram.

Variations and Typical Scenarios:

- **Concentrated forces only:** If a beam has only point loads (and no distributed load), the shear diagram will be **piecewise constant** (flat lines) with jumps at each load. The moment diagram will be **piecewise linear** (straight-

line segments), with corners (changes in slope) at the load points. This is perhaps the simplest case. For example, a two-point-load scenario: shear is a rectangle shape dropping at each load; moment is a tent-shaped piecewise linear graph. Make sure to calculate the correct heights of those jumps (equal to loads) and the slopes of moment lines (equal to the shear values in each region).

- **Uniformly distributed load:** For a uniform load (w constant over some span), the shear diagram will be a straight line sloping downward. The total drop in shear over that span equals $w \times$ (span length). The moment diagram over that span will be a parabola (since the slope of M is changing linearly). A classic example is a simply supported beam with uniform load: shear diagram is a downward sloping line from $+wL/2$ at left support to $-wL/2$ at right support, crossing zero at midspan; moment diagram is an upward-opening parabola, zero at supports and maximum at midspan ($wL^2/8$). You should recognize that shape; if your diagram for a uniform load doesn't look like a neat symmetric parabola (for a symmetric span), double-check your math.
- **Linearly varying (triangular) load:** If $w(x)$ varies linearly (say starts at 0 at one end and increases to some max at the other), the shear diagram will be a curve (specifically a quadratic curve, since $dV/dx = -w(x)$ is linear). The moment diagram will then be a cubic curve. This is more complex but the construction principle is the same: find shear at key points (integrate area under w graph), plot those, it will be curved, etc. The FE exam might not require detailed plotting of a cubic, but qualitatively you should know, for instance, that with a triangular load the moment diagram tends to be skewed (not symmetric) and the max moment shifts toward the heavier load side.
- **Cantilever beams:** These have different boundary conditions (moment and shear at the fixed end can be nonzero, and at the free end, $V = 0$ and $M = 0$ usually unless an end load or couple is applied right at the tip). For a cantilever with an end load, the shear diagram starts at the fixed end equal to that load (reaction) and then instantly drops to zero after the load at the tip (since the free end must carry no internal shear beyond the tip). The moment diagram for a cantilever with an end load is a triangle: maximum at the fixed end ($M = P \times L$ if P at the tip length L), linearly decreasing to zero at the free tip. If an exam question involves a cantilever, remember that sign conventions still apply – a downward load at the free end creates a negative shear at the fixed support if you assume the positive direction differently, but sticking to our sign convention, if we cut at the fixed end and consider the section to the left (the wall side), the internal shear in the wall actually points downward on that face to hold up the load (which would be a negative shear by our usual convention defined for the beam interior). It can get confusing, so it's safest to consistently cut the beam and draw internal forces on the **part attached to the supports** for sign. In any case, cantilever diagrams are often mirror-opposites of simply supported ones in shape (e.g., a uniform load on a cantilever yields a triangular shear diagram and a parabolic moment diagram, just like simply supported, but "flipped" and with the max moment at the fixed end instead of midspan).
- **Combined load cases:** Many beams have a mix of loads – e.g. a uniform load plus a point load, or multiple point loads. In constructing diagrams, handle one load at a time and superimpose, or do segment by segment. Superposition works because of linearity: you can draw the shear/moment from the uniform load and from the point load separately and then add them (point by point) to get the total diagrams. This can be quicker if the loads are conceptually separate. For instance, a beam with a uniform load and one point load: draw the uniform load's diagrams (nice smooth curves), then overlay the effect of the point load (which would add a constant shear in one region and a jump at the point, and add a linear moment segment and change slopes after the point). Ensure continuity where you superimpose. The FE exam may not expect you to do full superposition in 6 minutes, but knowing that shear/moment diagrams add up is useful for checking: the peak moment from combined loading will be the sum of peak moments if they occur at the same location or you might need to check multiple locations.
- **Internal hinges or discontinuities:** (This is more structural analysis than a typical FE Mechanical problem, but just in case) – if a beam has an internal pin (hinge), the moment diagram will drop to zero at that hinge (moment cannot be transferred through a pin), while the shear diagram can pass through continuous (the pin doesn't interrupt shear). You'd construct diagrams on each side of the hinge separately. Usually, FE Mechanical doesn't include such indeterminate or multi-span beams heavily, but be aware of the concept: a pin in the beam forces $M = 0$ there.

Special notes (Calculator and Efficiency): Constructing a full diagram can be time-consuming, so be strategic on the exam. If the question only asks for the moment at a specific point, you don't need to sketch the entire diagram – just do enough: perhaps find the reaction, then integrate w (or sum forces) to get V at that point, then integrate (or take moment of forces) to get M at that point. Use the diagram method mentally to avoid mistakes: for example, to get moment at 3 m, you can imagine drawing the shear diagram up to 3 m and finding the area under it. This is often easier than summing moments from scratch repeatedly. If you do draw diagrams, do it roughly to scale if possible and mark numeric values. In checking work, a quick mental estimate helps: e.g., "The load is 10 kN over 4 m, so total 40 kN, reactions ~20 kN each. Max moment should be around (20 kN * 2 m) = 40 kN·m if centered – does my detailed calc match that ballpark?" This kind of estimation using diagram areas (triangle area = ½ base * height for moment under uniform load, etc.) can catch errors. The allowed calculators won't sketch for you, but they can handle arithmetic of areas and slopes quickly – use them for addition, multiplication, or solving simple equations (like setting a quadratic moment expression to zero to find where moment crosses zero, etc.). Always double-check that your final answers (shear or moment values) have correct units and make sense (e.g., moment values should be zero at a free end or pin support, shear should equal reactions at supports, etc.).

Explanation & Analysis (Step-by-Step Guide): Constructing shear and moment diagrams may sound complicated, but it follows a **logical sequence of steps**. Here's a step-by-step method you can apply to virtually any beam problem on the FE exam:

1. **Draw the Beam and Supports:** Start by sketching the beam horizontally, mark all supports (pin, roller, fixed) and note their locations (e.g., distances). Indicate the span lengths. Mark the positions and magnitudes of all loads: point forces (with arrow and value), distributed loads (with intensity w and whether uniform or varying), and any applied couples (curved arrow symbol with

magnitude). This drawing is your reference. *Why?* A clear picture prevents mis-reading the problem and sets you up for the next steps. It's your "free-body diagram" of the entire beam. Always include coordinate x (usually from left end) and indicate it for clarity.

2. **Calculate Support Reactions:** Use static equilibrium on the whole beam to find reactions at supports. Sum of vertical forces $\sum F_y = 0$ gives one equation, sum of moments $\sum M_{\text{about a point}} = 0$ gives another, etc. For a simply supported beam or cantilever, this is straightforward. (If the beam is statically indeterminate – more supports than equations – the FE exam would likely give enough info or it's beyond scope. Assume determinate cases mostly.) Write down the reaction forces (and moments, if a fixed support provides a reaction moment). *These reactions are the starting values for your shear diagram.* For example, if the left support reaction is +10 kN upward, your shear diagram at the far left will jump from 0 to +10 kN. Don't skip this: wrong reactions = wrong diagram.

3. **Shear Diagram – Moving from Left to Right:** Begin at the left end of the beam (just to the right of the left support). Start your internal shear V value equal to the left reaction (taking upward as positive V on the left side segment). Then as you move right:

4. **Distributed loads:** When you encounter a distributed load spanning along the beam, the shear will *slope down*. The slope equals $-w$. If w is constant, draw the shear line with constant downward slope. The drop in shear over that region is $w \times$ (length of region). Mark the shear value at the end of that region. If $w(x)$ varies, the shear curve will be curved – you might need to compute shear at a couple of key points (like under the peak of a triangular load and at the end) by integrating $dV/dx = -w$. Plot those points and draw a smooth curve.
5. **Point loads:** When you reach a point load P (downward), represent it as an **instant drop** in the shear diagram. In practice, you draw a vertical line downward at that x location. The magnitude of the drop = P (so new V value = old V minus P). If the load is upward (rare), you'd jump up. Label the values before and after the jump to keep track. Continue after the load with the new shear value.
6. **No load regions:** Where there's no load, shear stays constant. So between isolated loads, draw horizontal lines. The shear right after a point load remains that value until another load or the end of span.
7. **Applied moments (couples):** A pure couple doesn't change shear, so on the shear diagram, it has no immediate effect (no jump). You just carry on the same shear value through that point. (We'll handle its effect on moment diagram in the next step.)
Continue this process through every segment of the beam until you reach the right end. When you include the right support reaction, you should see the shear value jump back to zero (assuming you started from zero at the far left outside the beam). If it doesn't, re-check your arithmetic – the final shear must equilibrate to zero after the last support for equilibrium closure.

8. **Moment Diagram – Integrate Shear (Area under Shear = Change in Moment):** Now plot the bending moment diagram below the shear diagram (aligned on the same x axis). Start at the left end: for a simply supported or free end, the moment there is 0 (common boundary condition). For a fixed end, moment starts at the reaction moment value (draw a jump at the end if needed in that case). Then move right:

9. **Under each span, the moment change** is the area under the shear diagram up to that point (because $M(x) - M(x_{\text{start}}) = \int_{x_{\text{start}}}^{x} V(x)\,dx$). Practically, if the shear diagram is a simple shape (rectangle, triangle), compute that area. For instance, if shear is constant 10 kN over 2 m, the moment will increase by $10 \times 2 = 20$ kN·m over that span (linearly, since area of rectangle gives a straight line increase). If shear is a line sloping from 10 kN to 6 kN over 4 m (a trapezoid area), compute the area (average shear = 8 kN times 4 m = 32 kN·m) to find the moment change, and it will be a curve (parabolic) increasing by that amount. You can also integrate piecewise: e.g. if $V(x) = 10 - 1x$ kN, integrate to get $M(x) = 10x - 0.5x^2 + C$. Usually easier: use geometry of areas. Mark the moment values at key points (ends of spans, under loads).
10. **Point loads (no moment jump):** Passing a point load does not cause a jump in moment, but remember the shear diagram had a jump. In the moment diagram that translates to a change in slope. So ensure that before the load, you were using one shear value, and after the load you use the new shear value for slopes. If you're doing it by areas: you don't do anything instantaneous at the load, you just continue integrating the new shear. The moment diagram will be continuous at that point (no sudden vertical moves). However, check if the slope changes: it should, because slope of M is V. Draw a dot or an open circle if needed to note the corner in the curve at that point (though usually we draw moment diagrams as continuous curves/lines, just with a corner).
11. **Applied moment (couple) – jump in M:** When you encounter an external applied couple M_0 (say at some $x = a$), **add or subtract that instantly** in the moment diagram. A positive couple (which would tend to sag the beam to the right of that point) means the moment diagram jumps *up* by M_0 at that point. Draw a vertical upward step of height M_0. A negative (counterclockwise, in our convention) couple would make a downward step. After the jump, continue with the moment change due to shear as before. Essentially, the internal moment just to the right of that applied couple = internal moment just to the left + the applied M_0.
12. **Continue to right end:** Keep summing areas segment by segment. The moment diagram can go up and then down, etc., depending on shear. When you reach the right support or end: for a simply supported beam, M should come back to 0 at the support. For a cantilever free end, M should end at whatever the applied moment at the tip is (usually 0 if no couple at tip). If your computed moment at the end doesn't match the known boundary condition, something went wrong (perhaps a wrong reaction or area calc). Adjust as needed.

13. **Mark Key Points on the Diagrams:** Label the peak of the moment diagram (this is often of interest because it dictates max stress). As noted earlier, the peak M typically occurs where V crosses zero. Verify that on your diagram: find where the shear line goes from positive to

negative – the moment at that x should be a local maximum. Mark that value. Also label any other important values: moments at specific points if the problem asks (e.g., "moment under the load = X") and shear at critical points (like just left/right of a load). Clarity here will help answer whatever the question is asking (and if the question isn't explicit, sometimes the largest moment or reaction is implicitly what they want).

14. **Double-Check Equilibrium and Continuity:** This is a sanity pass. Check that the **shear diagram** starts and ends at zero (unless there's some axial force component, which in pure beam problems there isn't). The sum of areas under the shear diagram (taking into account sign as positive above axis, negative below) over the whole beam should net to zero change in moment from one end to the other – which is consistent if M at both ends are the boundary values you expected (e.g., 0 and 0 for simply supported). Check that the **moment diagram** satisfies support conditions (zero at pins, fixed value at fixed supports, etc.). Also ensure the moment diagram's slope at any point equals the shear at that point (just a quick visual: where shear is zero, moment has flat slope; where shear is highest, moment slope is steepest). If something doesn't match (say your moment diagram seems to slope up while shear is negative in that region), that's a red flag. Correct it before finalizing your answer.

15. **Use the Diagram to Answer Questions:** With completed diagrams, even if roughly sketched, you can now answer many typical questions swiftly. Need the internal moment at 3 m from the left? Just read it off (or calculate via the area under shear up to 3 m). Need the maximum shear in the beam? It's likely at a support (the reaction), unless there's an unusual loading – your diagram shows it clearly. Need to identify where a beam might yield first? Find the max moment (for bending stress) or max shear if it's a shear-critical design – again, diagram highlights those. Essentially, once the diagram is there, the beam's internal force story is fully told, and extracting answers is usually trivial arithmetic or direct reading. On the FE exam, even if you don't draw the full nice diagram, mentally going through this construction helps ensure you consider all forces and moments and don't overlook a section.

Conclusion: Mastering shear and moment diagrams means you can deconstruct any beam load problem into manageable pieces. It's a bit of work up front, but it pays off in accuracy. By consistently applying the sign conventions and the dV/dx, dM/dx relationships, you'll find that what once seemed like a jumble of loads and supports becomes an orderly graph of lines and curves that you can interpret at a glance. Remember, not every exam problem warrants drawing the entire diagram – but having the skill to do so means you have a deep understanding of how loads, shears, and moments interrelate. This understanding is often what separates a confident solve from a panicked guess on exam day. Practice a few scenarios (different loads and support setups) during your prep, and you'll go into the exam with an intuition for "what the diagram should look like" – a priceless error-checking tool.

Topic 02 - Stress Transformations and Mohr's Circle

This topic deals with how a 2D stress state changes when viewed from different angles, how to find the most extreme stresses in a material, and how to predict yielding or failure under combined stresses. On the **FE Mechanical Exam**, you'll face problems asking for the **stress on an inclined plane**, the **principal stresses** (maximum and minimum normal stresses in the plane) and **maximum shear stress**, or whether a material **yields** under a given combined loading. **Mohr's circle** is a powerful graphical tool for these transformations – it saves time in finding principal stresses and their orientation without heavy computation. Finally, knowing the **yield criteria** (like Tresca and von Mises for ductile materials, and Mohr's theory for brittle materials) is crucial for checking if a given stress state will cause the material to yield or fracture under combined stresses.

K08.T02.S01 – Plane Stress Transformation (Stresses on an Inclined Plane)

Principle introduction: When a material element is under **plane stress** (stress in two perpendicular directions, with negligible out-of-plane stress), the stress on any other **inclined plane** through that element is different. Key points:

- **Arbitrary plane stress:** By rotating the reference axes by an angle θ, we can calculate the **normal stress** and **shear stress** on that new plane. These values come from equilibrium and geometry – they vary continuously with θ.
- **Why it matters:** The **extreme values** of stress (like maximum normal or maximum shear) occur on specific inclined planes. The exam may ask for stress at a given angle or those extreme values to assess safety.
- **Analytical approach:** Instead of guessing, we use **stress transformation formulas** (or Mohr's circle) to find the exact normal and shear stress on a plane at angle θ. This ensures we don't miss the worst-case stress.
- **Typical exam scenario:** Given σ_x, σ_y, and τ_{xy} at a point, you might be asked to find the stress components on a plane rotated, say, 30° from the x-axis. Using the transformation equations (or Mohr's circle) quickly gives the answer.

Exam Handbook Search Cues (Not affiliated with or endorsed by NCEES): *stress transformation, plane stress, rotated stress, inclined plane*

Equation Passport – Plane Stress Transformation – *Computes the normal and shear stress on a plane rotated by angle θ from the original axes in a 2D stress state.*

Name & Purpose: Plane Stress Transformation Equations – determine $(\sigma_\theta, \tau_\theta)$, the normal and shear stress on a plane at angle θ, given known stresses $(\sigma_x, \sigma_y, \tau_{xy})$ on orthogonal planes. This helps find stresses on any inclined section, which is crucial for identifying critical stress conditions.

Equation (Plane Stress Transform):

$$\sigma_\theta = \frac{\sigma_x + \sigma_y}{2} + \frac{\sigma_x - \sigma_y}{2}\cos 2\theta + \tau_{xy}\sin 2\theta$$

$$\tau_\theta = -\frac{\sigma_x - \sigma_y}{2}\sin 2\theta + \tau_{xy}\cos 2\theta$$

where **θ** is the angle (in the material plane) between the new plane's normal and the original x-axis.

Variables & Units:

- σ_x, σ_y – original normal stresses on the x-face and y-face (e.g. Pa or psi). Positive if **tensile** (pulling outward on the face).
- τ_{xy} – original shear stress on the x-face (acting in the y direction) and equivalently on the y-face (in the x direction) (Pa or psi). By sign convention, τ_{xy} is positive if it causes a **clockwise rotation** of the element (pair of shear forces forming a clockwise couple).
- σ_θ – normal stress on the plane rotated by angle θ (same units as σ_x). Tensile σ_θ pulls **perpendicular** to the θ-plane.
- τ_θ – shear stress on the plane at angle θ (same units as τ_{xy}). Positive τ_θ acts **along** the θ-plane in the direction that tends to rotate the element clockwise.
- θ – rotation angle of the plane **from the x-axis** to the new plane's normal (in degrees on the exam; ensure your calculator is in degree mode for computing $\sin 2\theta$, $\cos 2\theta$).

Assumptions & Scope:

- **Plane stress condition:** $\sigma_z = 0$. These equations apply when out-of-plane stress is negligible (common in thin plates or surfaces). They transform the in-plane stress state. *They are not for 3D stress; with nonzero σ_z, use 3D formulas (or include σ_z as needed in Mohr's 3-circle analysis).*
- **Static equilibrium:** The stress at a point is static – not rapidly changing – so transformation uses equilibrium of stress components. *Dynamic or localized effects aren't considered here.*
- **Continuum mechanics basis:** Material is continuous and the area we cut (plane at θ) is small enough that stress is uniform over it. *These formulas come from balancing forces on an infinitesimal element.*
- **Sign convention consistency:** The equations assume the standard sign convention (tensile = +, and the defined positive τ_{xy} as above). *Mixing sign conventions or axes definitions will lead to incorrect results.*

Limit checks (sanity tests):

- **θ = 0°:** $\cos 0° = 1$, $\sin 0° = 0$. The equations give $\sigma_0 = \sigma_x$ and $\tau_0 = \tau_{xy}$ – which makes sense: at 0° rotation, the plane is the original x-face, so stresses remain (σ_x, τ_{xy}).
- **θ = 90°:** $\cos 180° = -1$, $\sin 180° = 0$. The formulas yield $\sigma_{90} = \sigma_y$ and $\tau_{90} = -\tau_{xy}$. That matches

expectation: a 90° rotation aligns with the original y-face, which has normal stress σ_y, and the shear on that face is equal in magnitude and opposite in direction to the shear on the x-face.

- **Symmetry check:** If $\sigma_x = \sigma_y$ and $\tau_{xy} = 0$ (e.g. equal biaxial tension, no shear), then $\sigma_\theta = \sigma_x$ for all θ and $\tau_\theta = 0$. *This is an isotropic stress state in-plane, so rotating the element does nothing – a good consistency check.*
- **Max/min check:** The values of σ_θ and τ_θ as functions of θ are sinusoidal. They reach **extrema** when $d\sigma_\theta/d\theta = 0$ or $d\tau_\theta/d\theta = 0$. Solving those yields the principal and max shear orientations (we'll derive these in the next subtopic).

Use vs. Sibling Tools: Use these equations for a **numerical solution** when you need the exact stress on a given plane or want to double-check results. They are algebraically equivalent to reading values from **Mohr's circle** – in fact, Mohr's circle does the same calculations graphically. *If you're comfortable with Mohr's circle, you can skip heavy trig; if not, plug into these formulas.* Also note, for **strain transformations** a similar set of equations exist (with strain components and 2θ), and the approach is analogous.

Common exam traps:

- **Mixing up θ vs. 2θ:** Remember that the formulas use 2θ inside sine and cosine. A common mistake is to forget the factor of 2. For example, if the plane is at 30° to x-axis, use $\cos 60°$ and $\sin 60°$ in the equations.
- **Sign convention errors:** It's easy to get the sign of τ_θ wrong if you forget the convention. Stick to the rule given (clockwise couple → positive τ plotted upward on Mohr's circle). If the problem statement uses a different sign convention, adjust accordingly.
- **Degree vs Radian in calculator:** The exam's **allowed calculators** default to degree mode. If you're using these formulas, ensure your calculator is in degrees (or convert your angle to radians if you prefer radian mode). A sin/cos mix-up can lead to completely wrong answers.
- **Forgetting shear on perpendicular face:** In plane stress, the shear on the x-face and y-face are equal in magnitude. When using these formulas, τ_{xy} refers to the shear on the x-face (and τ_{yx} on the y-face is its opposite). No need to double it or anything – just use the given shear stress value as τ_{xy}.

Explanation & Analysis: In practice, to find stress on an inclined plane: **(1)** Identify the given stress state $(\sigma_x, \sigma_y, \tau_{xy})$ at the point (including signs). **(2)** Determine the angle θ of the plane in question relative to the x-axis (e.g. if the problem says "plane rotated 30° clockwise from the vertical y-axis," then θ = 60° from the x-axis, since x-axis is 90° from the y-axis minus 30°). **(3)** Plug θ into the transformation equations carefully. It can help to compute $\cos 2\theta$ and $\sin 2\theta$ first. **(4)** Solve for σ_θ and τ_θ. On the exam, you might also use **Mohr's circle method** as a check: plot the circle using (σ_x, τ_{xy}) and $(\sigma_y, -\tau_{xy})$, then measure the angle 2θ on the circle to find the new stress coordinates. Whether using formulas or Mohr's graph, the results should match. Keep track of units (stress units throughout) and sign directions, and you'll get the correct transformed stresses.

K08.T02.S02 – Principal Stresses & Maximum Shear (2D)

Principle introduction: Every 2D stress state has specific orientations where the **normal stress is maximized or minimized** – these are the **principal planes**, carrying **principal stresses** (σ_1 and σ_2). Likewise, there's an orientation where **shear stress** is maximized (with accompanying normal stress equal to the average stress). Essentials:

- **Principal stresses:** These are the **extreme values** of normal stress at the point (one maximum, one minimum) when the element is rotated to the principal orientation. No shear acts on a principal plane – principal stresses act **alone** on those faces.
- **Max shear stress:** In the plane, this is the largest shear stress value the point experiences, occurring on a plane oriented 45° away from the principal planes. On the max-shear planes, the normal stress equals the mid-value (average) of σ_1 and σ_2.
- **Calculation:** We can find σ_1, σ_2 by setting $\tau_\theta = 0$ in the transformation equations (because principal planes have zero in-plane shear). This leads to a simple formula (or we use Mohr's circle – principal stresses are where the circle crosses the horizontal axis). The maximum in-plane shear $\tau_{\max}$ is essentially the radius of Mohr's circle.
- **Why it's important:** Principal stresses tell us the **worst tensile or compressive stress** the material feels (important for failure in brittle materials), and $\tau_{\max}$ tells the worst shear (important for yielding in ductile materials or things like shear failure). Exam problems often ask for these values given σ_x, σ_y, τ_{xy}.
- **Mohr's circle connection:** Graphically, on Mohr's circle, σ_1 and σ_2 are the **rightmost** and **leftmost** points where the circle intersects the **normal-stress axis**, and $\tau_{\max}$ is the **top** (or **bottom**) point of the circle. This subtopic ties directly into using Mohr's circle (next section) or formulas to get numerical values.

Exam Handbook Search Cues (Not affiliated with or endorsed by NCEES): *principal stress, maximum shear, Mohr circle, 2D stress*

Equation Passport – Principal Stresses in Plane Stress – *Gives the two principal normal stresses in a 2D stress state (σ_1 = major, σ_2 = minor) and the maximum in-plane shear stress.*

Name & Purpose: Principal Stress Formulas (2D) – computes the **principal stresses** σ_1 and σ_2 in plane stress (the largest and smallest normal stresses at a point, where shear is zero), and the **maximum in-plane shear stress** $\tau_{\max}$. These results tell us the extremes of stress exposure – critical for evaluating failure criteria and material safety.

Equation (Principal stresses and max shear):

$$\sigma_{1,2} = \frac{\sigma_x + \sigma_y}{2} \pm \sqrt{\left(\frac{\sigma_x - \sigma_y}{2}\right)^2 + \tau_{xy}^2}$$

$$\tau_{\max,\ \text{in-plane}} = \sqrt{\left(\frac{\sigma_x - \sigma_y}{2}\right)^2 + \tau_{xy}^2} = \frac{\sigma_1 - \sigma_2}{2}$$

where by convention σ_1 is the **algebraically larger** principal stress and σ_2 the smaller. (If both are positive, σ_1 is the larger tension. If one is compressive, σ_3 may be 0; see notes below.)

Variables & Units:

- σ_1, σ_2 – principal stresses (Pa or psi). σ_1 = **major principal** (maximum normal stress), σ_2 = **minor principal** (minimum normal stress) in the plane. These inherently account for any sign (tension or compression).
- $\tau_{\max,\text{ in-plane}}$ – maximum shear stress in the plane (Pa or psi), occurring on planes oriented 45° from the principal planes. It equals the radius of Mohr's circle for the $\sigma_x, \sigma_y, \tau_{xy}$ state.
- σ_x, σ_y, τ_{xy} – same original stresses as defined in the previous subtopic (Pa or psi, with the same sign conventions). These are the inputs.
- *(If needed:)* θ_p – the **principal plane orientation** (angle from x-axis to the σ_1 principal plane normal). Although not explicitly in the formula above, it satisfies $\tan(2\theta_p) = \frac{2\,\tau_{xy}}{\sigma_x - \sigma_y}$ (we often compute this to find the exact angle of σ_1 or σ_2 if asked).

Assumptions & Scope:

- **Plane stress (2D) scenario:** We assume σ_x and σ_y are the only normal stresses (with $\sigma_z = 0$). Thus, the third principal stress $\sigma_3 = 0$ (out-of-plane stress). The formulas above inherently use that, giving two in-plane principals. *Be mindful: if a nonzero σ_z existed, true absolute σ_{min} could be σ_z; here we focus on the 2D plane.*
- **Material continuity:** We're finding stresses at a point in a continuous material. No discontinuities or stress concentrators are considered in this basic formula.
- **Ordering convention:** By "algebraically largest," we mean consider the numeric value with sign: e.g. +50 MPa > +20 MPa > 0 > –30 MPa. So σ_1 could be negative if the entire state is compressive (it would be the least negative value in that case).
- **Applicability:** These formulas come from solving $d\sigma_\theta/d\theta = 0$ for the transformation equations – essentially setting the shear to zero. They are always applicable for any state of plane stress to find extremal values.
- **In-plane vs out-of-plane shear:** $\tau_{\max,\text{in-plane}}$ is the maximum shear stress on any plane **within the given plane stress state**. If $\sigma_z = 0$ is considered a third principal stress, then the **absolute** maximum shear in 3D would be $\tau_{\max,3D} = \frac{\sigma_1 - \sigma_3}{2}$. Since here $\sigma_3 = 0$, $\tau_{\max,3D} = (\sigma_1 - 0)/2 = \sigma_1/2$ if σ_2 was zero or compressive. *In other words, if one principal is zero, sometimes the largest shear is between the top principal and zero.* However, on the exam in pure plane stress problems, usually they expect the in-plane $\tau_{\max}$ unless otherwise specified.

Limit checks:

- **No shear case:** If $\tau_{xy} = 0$, the formula for $\sigma_{1,2}$ simplifies to $\sigma_1 = \sigma_{\max} = \max(\sigma_x, \sigma_y)$ and $\sigma_2 = \sigma_{\min} = \min(\sigma_x, \sigma_y)$. The principal axes are just the original x and y directions in this case (since the shear was zero, the given orientation was already principal). $\tau_{\max}$ would then be $|(\sigma_x - \sigma_y)/2|$ – half the difference – which is the shear on planes at 45° if one stress is higher than the other. For example, if $\sigma_x = 100$ MPa, $\sigma_y = 40$ MPa, $\tau_{xy} = 0$, then $\sigma_1 = 100$ MPa, $\sigma_2 = 40$ MPa, and $\tau_{\max} = 30$ MPa (which occurs on planes 45° from x-axis).
- **Equal stresses:** If $\sigma_x = \sigma_y$ (say both 50 MPa) and a nonzero τ_{xy} exists, then plug into the formula: $\sigma_{1,2} = 50 \pm \sqrt{0 + \tau_{xy}^2}$. So $\sigma_1 = 50 + |\tau_{xy}|$, $\sigma_2 = 50 - |\tau_{xy}|$. This means one principal is above the common stress and one is below it by the amount of τ. For example, $\sigma_x = \sigma_y = 50$ MPa with $\tau_{xy} = 20$ MPa gives $\sigma_1 = 70$ MPa, $\sigma_2 = 30$ MPa. The average (50) is the center of Mohr's circle, and shear caused the spread of ±20. $\tau_{\max}$ in this case is 20 MPa – which makes sense, shear was present so the circle radius is τ.
- **All-around zero:** If $\sigma_x = \sigma_y = 0$ and $\tau_{xy} = 0$, trivially $\sigma_1 = \sigma_2 = 0$ and $\tau_{\max} = 0$. No stress at all – nothing to transform.
- **Orientation sanity:** The principal angle $\theta_p = 1/2 \arctan\left(2\tau_{xy}/(\sigma_x - \sigma_y)\right)$. If τ_{xy} is zero, $\theta_p = 0°$ or 90° (as expected). If $\sigma_x = \sigma_y$, then $\theta_p = 45°$ or $-45°$ (or equivalently 45° from x-axis) because the formula becomes $\arctan(\infty)$, indicating every 45° you get a principal swap. These align with known facts: equal perpendicular stresses plus shear produce principal planes at 45°.
- **Use vs. Alternative Methods:** This formula is a quick route to principal stresses without drawing anything. Use it when you need precise values fast. Alternatively, the **graphical Mohr's circle** approach gives the same results: you'd plot the circle and directly read σ_1 and σ_2 from where the circle meets the horizontal axis, and $\tau_{\max}$ from the top of the circle. On the exam, if you forget the formula, constructing Mohr's circle is a reliable fallback. Also note, for **principal strains**, there are analogous formulas (replacing σ with ε and using appropriate shear strain terms).

Common exam traps:

- **Forgetting one of the principal values:** The formula has a "±". Make sure to calculate **both** σ_1 and σ_2. It's not uncommon for hurried examinees to compute the "+" case and forget the "–" case, thereby missing one principal stress.
- **Mixing up which is σ_1 vs σ_2:** Always assign σ_1 as the larger (more tensile, or less compressive) and σ_2 as the smaller. The exam might explicitly ask for "maximum principal stress" (σ_1) or "minimum principal" (σ_2). If you swap them accidentally, you could mis-answer a question about, say, the factor of safety (which often uses σ_1).
- **Sign mistakes under the square root:** Remember the term under the square root is $\left(\frac{\sigma_x - \sigma_y}{2}\right)^2 + \tau_{xy}^2$. Both parts are **squared and added**, so the quantity is always non-negative. A common error is to drop a negative sign incorrectly or forget to square the 1/2 factor. Work carefully: compute $(\sigma_x - \sigma_y)/2$ first, square it, add τ_{xy}^2, then take the square root.
- **Using wrong units or mixing unit systems:** σ_1, σ_2, and $\tau_{\max}$ will have the same units as the input stresses. If σ is

given in ksi and you compute τ in MPa by mixing a conversion, you'll produce an inconsistent result. Stick to one unit system throughout the calculation.

- **Ignoring out-of-plane context:** If a problem mentions an out-of-plane stress (σ_z), do not use these 2D formulas blindly. In such cases, one of the "principal stresses" might actually be that σ_z. For example, if σ_z is not zero, then the absolute maximum shear involves σ_z as well (check if the problem expects a 3D consideration). The exam usually clarifies plane stress vs 3D scenario, so pay attention to wording.

Explanation & Analysis: The principal stress formula essentially comes from the quadratic equation you'd solve from the stress transformation. It gives an immediate way to find the **peaks of normal stress**. To apply it on the exam: **(1)** Plug in the given σ_x, σ_y, and τ_{xy}. **(2)** Carefully evaluate the term under the square root. **(3)** Compute σ_1 and σ_2. It's good practice to also find $\tau_{\max}$ at the same time (often needed for comparison to yield criteria). If time allows, **verify with Mohr's circle**: draw the circle – the center $C = (\sigma_x + \sigma_y)/2$, radius $R = \tau_{\max}$. Check that the circle's intersection points indeed match your σ_1 and σ_2. If σ_1 and σ_2 have opposite signs (one tensile, one compressive), the point where the circle crosses zero on the σ-axis tells you one of them is compressive. Also, consider the **orientation**: If the question asks "at what angle does σ_1 occur," use $\tan(2\theta_p) = 2\tau_{xy}/(\sigma_x - \sigma_y)$ to find $2\theta_p$, then halve it. For example, if $\tan(2\theta_p) = 1$, then $2\theta_p = 45°$, so $\theta_p = 22.5°$ (principal plane orientation). Principal stresses and max shear are fundamental checks for safety: e.g. a brittle material might crack if σ_1 exceeds a tensile strength, or a shaft might yield if τ_{max} exceeds shear yield strength. So, the exam will frequently combine this calculation with a **failure criterion** (coming up next).

K08.T02.S03 – Mohr's Circle for Plane Stress (Graphical Method)

Principle introduction: Mohr's circle is a geometric construction that encapsulates the stress transformation equations in a visual form. It's a circle drawn in **σ-τ space** (normal stress on horizontal axis, shear on vertical) that makes finding σ_1, σ_2, and $\tau_{\max}$ almost trivial. Key insights:

- **Graphical representation:** Each 2D stress state corresponds to a unique circle. The center of the circle lies at the mean normal stress, and the radius equals the maximum shear stress. Every point on the circle represents the stress state on some rotated plane.
- **Principal stresses & orientation:** Where Mohr's circle intersects the horizontal axis gives the **principal stresses** (τ = 0 at those points). The angle you move on the circle corresponds to twice the physical angle. Specifically, a **2θ** rotation on the circle (from one point to another) equals a θ rotation of the physical plane. This means the angle between the radius to a point on the circle and the horizontal axis is 2× the real angle of that plane.
- **Using Mohr's circle:** To construct it, plot two initial points: (σ_x, τ_{xy}) and $(\sigma_y, -\tau_{xy})$. These represent the stress on the x-face and y-face of the element. They are opposite ends of a diameter of the circle. Draw the circle through these points. Then you can **read off** σ_1 and σ_2 directly where the circle crosses σ-axis, and $\tau_{\max}$ at the top/bottom of the circle.
- **Why it matters for exam:** Mohr's circle can solve transformation problems **without plugging into formulas**. It's especially handy if you prefer visual reasoning or need to double-check calculations. On the FE exam, even if you're rusty on the formula, you can often sketch a quick Mohr's circle on your scratch paper to get principal stresses or the stress at a specified angle.
- **Sign convention on the circle:** By convention, we plot **tensile σ to the right** (positive σ), and **shear upward when it tends to rotate the element clockwise** (that is, a positive τ_{xy} is plotted as a point above the σ-axis). This convention ensures that a **counterclockwise physical rotation** of the element corresponds to moving **counterclockwise around Mohr's circle**. Keeping this straight is important for reading orientation correctly.

Exam Handbook Search Cues (Not affiliated with or endorsed by NCEES): *Mohr's circle, principal plane, stress diagram, graphical stress*

Diagram Passport – Mohr's Circle (Plane Stress)

- **Diagram title and role: Mohr's Circle for Stress (2D)** – a nomographic tool that graphically represents all possible stresses on planes through a point. It helps you make decisions about **principal values** and **orientations** quickly, by simple geometry rather than algebra.
- **Axes and quantities:** The circle is plotted on a coordinate system where the horizontal axis is **normal stress σ** and the vertical axis is **shear stress τ**. Units of σ and τ are the same (Pa, psi, etc.), and they are plotted to the same scale on both axes. Positive σ (tension) increases to the right; compressive (negative) to the left. For shear, the sign convention is crucial: typically, **upward τ** is taken for a shear that, on the original element, causes a clockwise rotation (this matches the right-hand rule if you imagine the Mohr's circle derivation). Each point on the circle thus corresponds to the stress state on some plane, with coordinates (σ_n, τ_n).
- **Key features and points:** The **center C** of Mohr's circle lies at $\left(\frac{\sigma_x+\sigma_y}{2},\ 0\right)$ – the average of the normal stresses on the two perpendicular faces. The **diameter** of the circle connects the points representing the original perpendicular planes: one end (σ_x, τ_{xy}), the other $(\sigma_y, -\tau_{xy})$. The **radius R** is given by $R = \sqrt{(\frac{\sigma_x-\sigma_y}{2})^2 + \tau_{xy}^2}$, which equals $\tau_{\max}$ (the maximum shear). The circle will intersect the horizontal axis at two points: these are $(\sigma_1, 0)$ and $(\sigma_2, 0)$ – the principal stresses, where shear is zero. The top of the circle is $(s,\ \tau_{\max})$ and the bottom is $(s,\ -\tau_{\max})$, where $s = \frac{\sigma_x+\sigma_y}{2}$ is the center's σ-coordinate. These top/bottom points represent the planes of maximum shear stress (they experience $\tau_{\max}$ along with a normal stress s). If one of the original stresses is zero, the circle passes through the origin (important for combined stress cases).
- **How to read & use it (exam-style):** To **construct Mohr's circle**, you do the following: *(i)* plot the two known stress points (for the x-face and y-face). *(ii)* Draw a straight line between them – that's the diameter. *(iii)* Determine the center (midpoint of that line) and radius (half the distance between the points). *(iv)* Draw the circle. Now for reading: σ_1 and σ_2 are read directly where the circle crosses the σ-axis (these are numeric values of principal stresses). $\tau_{\max}$ is the circle's topmost point's τ value (the radius length). To find the **stresses on a plane at a specific angle θ** from the x-axis, measure an angle 2θ *from point A (x-face)* **on the circle** – moving

counterclockwise for a physical plane rotated counterclockwise. The coordinates of the new point you reach on the circle are $(\sigma_\theta, \tau_\theta)$. For example, for a plane rotated 30° counterclockwise from x-axis, move 60° counterclockwise on the circle from point A. The resulting point's coordinates give σ and τ on that plane. This method bypasses plugging numbers into formulas and is particularly convenient if you have a protractor or just need a qualitative sense (on the exam, you might do a rough sketch to double-check your calculations).

- **Key relationships:** The angle on Mohr's circle is double the physical angle. Also note that the **principal planes** are 90° apart physically, which shows up as 180° separation on the circle (half the circle apart). And planes of maximum shear are 45° from principal planes (physical) which is 90° on Mohr's circle (a quarter-circle apart). This helps because on the circle diagram, a quarter-turn from the principal stress point will land you at the top of the circle (max shear).

Common misreads & pitfalls:

- **Confusing σ and τ axes:** Always label your axes. If you accidentally swap and plot shear on horizontal, etc., you'll end up with nonsense. Remember: horizontal = normal stress, vertical = shear stress.
- **Sign convention mix-up:** The most frequent error is plotting the shear point incorrectly. For example, say τ_{xy} is given as +30 MPa (meaning on the x-face it acts in the positive y direction). Using the convention (cw couple = positive), that means the point for the x-face is (σ_x, +30). The y-face then has (σ_y, –30). If you plot the sign of τ wrong (e.g. both points above axis or both below), your circle might still form but you'll interpret angles incorrectly (e.g. you might get principal stress orientation off by 90°). Stick to the rule: one point goes above, the other below by equal magnitude.
- **Not doubling the angle for orientation:** If you use the circle to find the plane at which a certain stress occurs, remember to halve the angle you measure on the circle. E.g., you find that moving 80° along the circle from the x-face point gets you to a point of interest – that corresponds to a 40° physical rotation. Many mistakes on exam questions happen when someone reports 2θ (the Mohr's circle angle) as θ.
- **Missing the fact that compressive stresses plot to the left:** If σ values are negative (compressive), your circle center might lie to the left of the origin. This is fine – just keep track that σ_1 could be a negative number (the more rightward intersection might still be negative if both principal stresses are compressive). Students sometimes mistakenly take the right intersection as σ_1 assuming it's positive – check the scale. σ_1 is just the rightmost intersection, even if that's on the negative side.
- **Using Mohr's circle for 3D without modifications:** Mohr's circle as drawn here is for plane stress (one circle). In 3D stress, you'd technically have three principal stresses and you can draw three circles (one for each pair). That's beyond FE scope typically, but just note that a single Mohr's circle approach here doesn't handle a nonzero σ_z unless you incorporate it in the points. The exam would rarely if ever ask for 3D Mohr's circles, but it might list the concept. For plane stress problems, one circle is all you need.

Explanation & Analysis: *Mohr's circle is essentially a visual solver for the transformation equations.* By representing the state of stress as points on a circle, it converts the trigonometric relationships into simple geometry. On exam day, if a question asks for principal stresses or stresses at a rotated angle, **don't hesitate to sketch a Mohr's circle**. Even a rough sketch can help avoid algebra mistakes: plot σ_x and σ_y to scale (with sign), find the center, use a compass or just eyeball the radius. From the circle, identify σ_1 and σ_2. This method also builds intuition: for instance, if τ_{xy} is large, you'll see a big radius, meaning principal stresses deviate a lot from the average. If σ_x and σ_y are very different, you'll see the circle is large too (because $(\sigma_x - \sigma_y)/2$ drives radius). Mohr's circle also **unifies all plane orientations** in one picture – any stress state on any plane is somewhere on the circle. This can be comforting: you know the circle bounds what's possible (e.g. you immediately see the maximum and minimum σ and τ). In summary, use Mohr's circle as a versatile tool: to cross-check calculations, to find orientation angles quickly (by measuring half-angles), or to solve problems when you blank on the formula. With practice, it becomes a quick doodle that yields reliable results under exam pressure.

K08.T02.S04 – Yield Criteria under Combined Stress (von Mises, Tresca, Mohr's Theory)

Principle introduction: Determining the stresses (σ_1, σ_2, τ_{max}, etc.) is half the battle – the other half is deciding if those stresses will cause the material to **yield or fail**. That's where **failure criteria** come in. Different materials and loading conditions require different criteria:

- **Ductile materials (metals, ductile alloys):** These typically fail by **yielding** (permanent deformation) when the stress reaches a certain condition. Two common criteria are used:
- *Maximum Shear Stress Theory (Tresca):* Predicts yielding when the **maximum shear stress** in the material reaches a critical value (related to yield strength). Essentially, when $\tau_{\max} = S_y/2$ (half the yield strength in tension), yielding begins. This is equivalent to $\sigma_1 - \sigma_3 = S_y$ (difference between largest and smallest principal stress equals S_y). It's a simple, conservative criterion.
- *Distortion Energy Theory (von Mises):* Predicts yielding when the **distortional energy** in the material equals that at yield in a simple tension test. It results in the **von Mises stress** σ_{vm}, and yielding occurs when $\sigma_{vm} = S_y$. The von Mises stress is a single combined-stress value computed from the principal stresses (formula given below). This theory is slightly more accurate (less conservative) for ductile metals than Tresca.
- **Brittle materials (cast iron, ceramics):** These typically **fracture** rather than yield. They often have different strengths in tension vs compression. A common approach:
- *Maximum Normal Stress Theory:* A brittle material is assumed to fail when one of the principal stresses exceeds the material's strength in tension or compression. In practice, this means if σ_1 (max tensile) ≥ S_{ut} (ultimate tensile strength) **or** σ_3 (max compressive, i.e. most negative) ≤ $-S_{uc}$ (ultimate compressive strength, taken as a negative value), then fracture occurs. This is a simplistic criterion.
- *Mohr's Theory (Coulomb-Mohr):* An improvement on the above, it accounts for the different tensile and

compressive strengths by constructing a failure envelope in the Mohr's circle plane. Essentially, you draw Mohr's circles for the uniaxial tensile strength (S_{ut}) and compressive strength (S_{uc}) and then connect their tangential points. Failure is predicted if the Mohr's circle for the given stress state touches or exceeds this envelope. It's like a piecewise linear criterion that reduces to the maximum normal stress theory at pure tension or compression, but is more accurate for combined states (like one side in tension, one in compression).

- **Why criteria matter:** The FE exam might directly ask, "According to Tresca (or von Mises), does this combined stress cause yield?" or "Calculate the factor of safety given a yield strength and a combined stress state." You must know how to apply the correct formula. If the material type is mentioned (ductile vs brittle), use the appropriate theory.
- **Typical exam tasks:** Computing a **factor of safety** (FS) for a given state: FS is usually defined as $N = \frac{\text{Failure threshold}}{\text{Actual stress metric}}$. For example, under von Mises criterion, $N = \frac{S_y}{\sigma_{vm,\,actual}}$. Under Tresca, $N = \frac{S_y}{\sigma_1 - \sigma_3}$ (since yield when $\sigma_1 - \sigma_3 = S_y$). For brittle (Mohr), you might check tensile and compressive separately: e.g. $N_t = \frac{S_{ut}}{\sigma_1}$ and $N_c = \frac{S_{uc}}{-\sigma_3}$ and take the minimum if both apply. The exam could also ask conceptually which theory is more conservative or appropriate.

Exam Handbook Search Cues (Not affiliated with or endorsed by NCEES): *yield criterion, Tresca, von Mises, shear stress theory, Coulomb-Mohr*

Definition/Equation Passport – Combined Stress Yield Criteria

Plain-language definition: *Yield and failure criteria* are rules that tell us **when a material will start to deform plastically or break** under a given combination of stresses. They take the multi-axial stress state (σ_1, σ_2, σ_3) and boil it down to a condition (often an equivalent single stress) to compare against a strength limit from a simple test. In simple terms, they answer: "Given these combined stresses, has the material **reached its limit**?"

Where it matters (exam impact): These criteria show up in questions about **design safety and failure**. For instance, you might be given a shaft with bending and torsion and asked whether it yields (so you'd compute σ_{vm} and compare to S_y), or asked which theory to use for a brittle material vs a ductile one. Often the exam will specify "using the von Mises criterion…" or similar. You'll also need to know which formula corresponds to which criterion and how to apply it.

Key formulas (by criterion):

- **Tresca (Max Shear Stress Theory):** Yield occurs when $\tau_{\max} = \frac{S_y}{2}$, or equivalently when $\sigma_1 - \sigma_3 = S_y$ (since in 3D, $\tau_{\max} = \frac{\sigma_1 - \sigma_3}{2}$, with $\sigma_1 \geq \sigma_2 \geq \sigma_3$). Here S_y is the yield strength in tension (same units as σ). In a plane stress case ($\sigma_3 = 0$), this simplifies to $\sigma_1 = S_y$ or $\sigma_3 = -S_y$ as the yield onset conditions (whichever happens first). *Tresca essentially says the material yields when the range of principal stresses equals what it can withstand in pure tension.*
- **Von Mises (Distortion Energy Theory):** Yield occurs when $\sigma_{vm} = S_y$, where the **von Mises equivalent stress** σ_{vm} is defined as
$$\sigma_{vm} = \sqrt{\frac{1}{2}[(\sigma_1 - \sigma_2)^2 + (\sigma_2 - \sigma_3)^2 + (\sigma_3 - \sigma_1)^2]}.$$
In plane stress ($\sigma_3 = 0$), this reduces to $\sigma_{vm} = \sqrt{\sigma_x^2 - \sigma_x\sigma_y + \sigma_y^2 + 3\tau_{xy}^2}$ (a formula sometimes seen in handbook). Von Mises theory says yielding is determined by the **energy of distortion** in the material – it's indifferent to a hydrostatic (equal in all directions) stress component.
- **Mohr's Theory (for Brittle Fracture):** Failure occurs if the Mohr's circle for the stress state intersects the **failure envelope** defined by two lines: one line tangent to the Mohr's circle at ($\sigma = S_{ut}, \tau = 0$) and another tangent at ($\sigma = -S_{uc}, \tau = 0$). In practice, this can be checked by ensuring:
    - $\sigma_1 < S_{ut}$ (no principal tension exceeds tensile strength)
    - $\sigma_3 \succ S_{uc}$ (no principal compression exceeds compressive strength in magnitude)
    If both are satisfied, failure hasn't occurred. If either $\sigma_1 \geq S_{ut}$ or $\sigma_3 \leq -S_{uc}$, brittle fracture is expected. For intermediate cases where one principal is tensile and one compressive, the linear envelope between those points is used: the condition can be written as $\frac{\sigma_1}{S_{ut}} - \frac{\sigma_3}{S_{uc}} = 1$ (approximately, when both σ_1 tensile and σ_3 compressive are significant). This is essentially the **Coulomb-Mohr** criterion. *In simpler terms, brittle materials fail if any normal stress exceeds the material's strength in that mode.*

Variables and units:

- $\sigma_1, \sigma_2, \sigma_3$ – principal stresses (Pa, psi). Make sure to plug them in with proper sign: tensile positive, compressive negative for these criteria.
- S_y – yield strength of the material in tension (Pa, psi). For Tresca/von Mises (ductile criteria), we assume yield strength in tension = yield strength in compression (almost always true for ductile metals). Use the value given for yield (usually uniaxial yield stress from a tension test).
- σ_{vm} – von Mises equivalent stress (Pa, psi). It's a computed value representing a combination of the principal stresses. It is always positive or zero (since it's a square-root of sum of squares).
- S_{ut} – ultimate tensile strength of brittle material (Pa, psi). The stress at which it breaks under tension.
- S_{uc} – ultimate compressive strength of brittle material (usually given as a positive number for the magnitude, Pa or psi). For brittle materials S_{uc} can be much larger than S_{ut} (they might handle compression better than tension).
- Factor of Safety, N – a unitless ratio often used: $N = \frac{\text{strength}}{\text{stress demand}}$. Each theory defines "stress demand" differently (e.g. σ_{vm} for von Mises, $\sigma_1 - \sigma_3$ for Tresca, etc.).

Assumptions & scope:

- **Static, room-temperature loading:** These criteria assume static loading conditions (no fatigue, no high strain-rate or creep effects) and moderate temperatures (no creep). The FE exam's scope for these theories is static failure.
- **Isotropic materials:** The formulas assume material properties are the same in all directions (no anisotropy). Yield strength is taken from a uniaxial test and applied generally.
- **Ductile vs brittle clarity:** Use **Tresca or von Mises** for metals and ductile plastics – materials that yield significantly before breaking. Use **Mohr's (Coulomb-Mohr) or max normal stress** for things like cast iron, concrete, ceramics – materials that crack without yielding. The exam usually hints at this by naming the material or directly stating which theory to apply.
- **Yield vs ultimate:** For ductile criteria, the "failure" threshold is yielding (so use yield strength S_y). For brittle, it's fracture (so use ultimate strength S_u). Do not confuse yield strength with ultimate strength – plugging the wrong one in the formula would be incorrect.
- **Tresca vs von Mises usage:** Both apply to ductile materials. Tresca is easier to compute by hand (just need max and min principal difference). Von Mises is more accurate but a bit more computational. The FE Handbook provides von Mises formula explicitly; you choose based on question requirement. If not specified, von Mises is often preferred for design (due to closer accuracy). If the exam question asks which is more conservative: Tresca is (predicts yield sooner for any given state, since the Tresca yield surface is a hexagon circumscribing the von Mises ellipse in principal stress space).

Typical values and differences:

- For **pure shear** loading: Tresca says yield when $\tau = S_y/2$. Von Mises says yield when $\tau = S_y/\sqrt{3} \approx 0.577S_y$. Thus, von Mises allows a higher shear stress before yield (because it considers the energy; pure shear has no hydrostatic component, and von Mises yields a bit later). This difference exemplifies the **conservatism** of Tresca – it will trip at a lower shear stress than von Mises.
- For a **balanced biaxial tension** ($\sigma_1 = \sigma_2$ = some value, $\sigma_3 = 0$): Tresca yields when that value reaches S_y (since $\sigma_1 - \sigma_3 = S_y$ gives $\sigma_1 = S_y$ if $\sigma_3 = 0$). Von Mises yields when $\sqrt{\sigma^2 + \sigma^2 - \sigma * \sigma + 0} = S_y$, i.e. $\sqrt{\sigma^2 + \sigma^2 - \sigma^2} = S_y \rightarrow \sigma = S_y$. In this equal-biaxial case both criteria coincide (interesting fact: von Mises and Tresca give same result for equal tension in two directions).
- For **one tension, one compression** (e.g. $\sigma_1 > 0$, $\sigma_2 < 0$): the criteria can differ. E.g., $\sigma_1 = 200$ MPa, $\sigma_2 = -50$ MPa, $\sigma_3 = 0$. Tresca: $\sigma_1 - \sigma_3 = 200$ MPa (so compare to S_y). Von Mises: you compute a combined value. If $S_y = 250$ MPa for the material, Tresca would say safe (200 < 250), whereas von Mises would calculate $\sigma_{vm} = \sqrt{\frac{1}{2}\left[\left(200-(-50)\right)^2 + (-50-0)^2 + (0-200)^2\right]} = \sqrt{\frac{1}{2}[250^2 + 50^2 + 200^2]}$ MPa ≈ 180 MPa, which is < 250, also safe. In many cases, von Mises and Tresca will agree on pass/fail; when they differ, Tresca will flag failure slightly earlier.
- For **brittle materials**, typical S_{ut} vs S_{uc}: e.g., cast iron might have $S_{ut} = 20$ ksi, $S_{uc} = 80$ ksi. The Coulomb-Mohr envelope in such a case is much closer on the tension side. That means a small tension combined with compression can cause failure because the tensile side is weak. The maximum normal stress theory (which is basically a special case of Coulomb-Mohr) would just check each principal: if any >20 ksi tension or < -80 ksi compression, predict failure. Coulomb-Mohr is a bit more nuanced for mixed cases but conceptually similar.
- **Special notes (calculator usage):** For von Mises, you'll be squaring potentially large numbers – watch out for calculator overflow or input mistakes. Using the memory or writing down intermediate squared terms can help avoid error. On a TI-36 or Casio, you might compute $(\sigma_1 - \sigma_2)^2$ separately, etc., then sum. Also, ensure you correctly input the square root of one-half times that sum. Many calculators allow a single line input – double-check parentheses. For Tresca, it's straightforward: just find max principal difference, divide by yield strength.

Common exam pitfalls:

- **Using the wrong criterion for the material:** If a problem says "brittle", using von Mises or Tresca may not be appropriate (brittle doesn't yield, it fractures – though the exam might still expect you to apply max normal stress theory). Conversely, applying brittle criteria to a ductile metal will give an overly conservative or just incorrect result regarding yield. Follow the clues: steel → use von Mises/Tresca; cast iron → use Mohr/maximum normal stress.
- **Misidentifying σ_1 and σ_3:** In Tresca's $\sigma_1 - \sigma_3$, be sure you correctly pick the largest and smallest principal. For plane stress with $\sigma_3 = 0$, if both σ_1 and σ_2 are positive, then $\sigma_3 = 0$ is actually the smallest (since it's zero vs positive σ_2). So $\sigma_1 - \sigma_3$ would be $\sigma_1 - 0 = \sigma_1$. If one principal is negative, that negative one is σ_3. It's easy to plug in wrong values if you haven't clearly ordered your principals. Take a moment to list them in descending order before applying Tresca.
- **Forgetting factor of safety:** If the question asks for factor of safety, don't stop at computing the stress. You must **compare to strength**. For example, you might correctly compute $\sigma_{vm} = 100$ MPa, and be given $S_y = 250$ MPa. The factor of safety N is $250/100 = 2.5$. Make sure to report FS if that's what's asked, rather than the raw stress value. And if asked whether yielding occurs, essentially you're checking if FS ≤ 1.
- **Units mismatch:** Strengths S_y, S_{ut}, S_{uc} are given in certain units (perhaps MPa or psi). Ensure your computed stress (σ or τ or σ_{vm}) is in the **same units** before comparing. If you find σ_{vm} in Pa but S_y was given in MPa (common if you forget to scale), you'll be off by a factor of 10^6! Always check units consistency in these comparisons.
- **Envelope vs exact Mohr's circle in Coulomb-Mohr:** If confronted with a combined state (σ_1 tensile, σ_2 or σ_3 compressive for a brittle material), some examinees might try to draw detailed Mohr's circles. While that's conceptually fine, remember that Coulomb-Mohr's

condition can be checked algebraically with the linear equation mentioned or simply by checking that neither principal exceeds the allowed limits. Overcomplicating the graphical solution can waste time. Use the quicker check: ensure $\sigma_1/S_{ut} + \sigma_3/S_{uc} \leq 1$ (with sign of σ_3 treated as negative in that formula) as an approximate criterion for no failure.

Explanation & Application: To decide if a given stress state will cause yielding or failure, **first identify the material behavior** (ductile vs brittle) and the criterion to use (often the problem will tell you, e.g. "using von Mises criterion…"). Then, **compute the necessary stress metric**: for von Mises, find σ_{vm}; for Tresca, find σ_1 and σ_3 and take their difference; for brittle (Mohr), find σ_1 and σ_3 and compare to strengths. Finally, **compare to the material strength**. For example, suppose a problem gives a steel shaft with a certain bending and torsion. You'd calculate σ_{bend}, $\tau_{torsion}$ at the critical point, combine them to σ_{vm}, and then see if $\sigma_{vm} > S_y$ or not (or compute FS = S_y/σ_{vm}). Or, if a brittle rod has some axial and transverse loads giving σ_1 and σ_3, you'd ensure $\sigma_1 < S_{ut}$ and $\sigma_3 \succ S_{uc}$. Always remember: **Tresca vs von Mises** for ductile – if not told which, von Mises is a safe default since it's commonly used (unless you need a quick conservative check, then Tresca is fine). **Coulomb-Mohr (or max normal stress)** for brittle – because brittle materials don't care about shear as much, they break when the normal stress is too high. By mastering these criteria, you can confidently answer exam questions about whether a part will survive a given load or how safe it is. Each formula condenses a multi-axial stress state into a single number to compare with a single strength number – make sure you use the right formula for the right material, and you'll avoid the common pitfalls.

Topic 03 - Stress and Strain Caused by Axial Loads

Topic Introduction: Axial loads create **normal stresses and strains** in structural members – a fundamental scenario in mechanics of materials. On the **FE Mechanical Exam**, you'll often face questions asking for internal stress in a rod under tension/compression, the resulting change in length, or effects of temperature changes when expansion is constrained. Mastering these basics is crucial: many problems reduce to "*a load P stretches a bar – how much stress or elongation results?*" or "*a temperature rise tries to expand a member – what stress is induced if it can't expand?*". The typical question archetypes include computing axial **stress (σ)** from a given force and area, calculating axial **strain (ε)** or deformation (δ) given loads and material properties, or determining thermal expansion effects. This topic underpins more complex scenarios, so a clear grasp here ensures you won't stumble on the building-block concepts later.

K08.T03.S01 – Uniaxial Stress–Strain Behavior and Hooke's Law

Principle introduction: Normal stress and strain describe how a material stretches or compresses under axial load in its elastic range. Key points:

- **Stress (σ)** is the internal force intensity, defined as load divided by cross-sectional area (σ = P/A). It measures how concentrated a force is inside a member (units: Pa or psi).
- **Strain (ε)** is the material's deformation response, defined as change in length over original length (ε = ΔL/L). It's dimensionless (m/m or in/in) – e.g. a strain of 0.001 means a 0.1% length change.
- **Hooke's Law**: In the linear elastic range (for small strains), stress varies directly with strain. The proportionality constant is Young's modulus E, which represents the material's stiffness. So **σ = E · ε**. This linear relation holds up to the material's **proportional limit**.
- **Young's Modulus, E**, (units: Pa or psi) is a fundamental material property – higher E means a stiffer material (it takes more stress to achieve the same strain). For example, steel's E ≈ 200 GPa, aluminum's ≈ 70 GPa.
- In a **uniaxial** test (one-dimensional loading), the initial straight-line portion of the stress–strain curve follows Hooke's law. Beyond the elastic limit, the curve deviates (yielding and plastic deformation), where Hooke's law no longer applies. It's crucial to apply σ = Eε **only within the elastic range**.

Equation Passport – Hooke's Law (Linear Elastic): Calculates normal stress from strain (or vice versa) in a material's linear range.

Formula: $\sigma = E\,\epsilon$

Variables:

- σ = normal stress in the member (Pa or psi)
- E = Young's modulus of the material (Pa or psi)
- ϵ = normal (engineering) strain = $\Delta L/L$ (dimensionless)

Assumptions & Scope:

- Material is **homogeneous and isotropic** (same E throughout, same in all directions).
- Deformation is **elastic** and small (within proportional limit, so stress–strain is linear and returns to zero when load is removed).
- **Uniaxial loading:** The formula applies along the direction of a single normal stress. (If other perpendicular stresses exist, see 3D elasticity relations in a later subtopic.)
- Temperature is constant (no thermal strain included here).

Limit checks: If strain $\epsilon = 0$, then $\sigma = 0$ (no deformation, no stress). If E is extremely large (stiff material approaching rigid), a given stress produces almost zero strain. As $\epsilon \to 0$ or $E \to \infty$, the material is essentially unyielding. If E is small (rubbery material), the same stress yields a larger strain.

Use vs. sibling equations: Use $\sigma = E\epsilon$ for **normal axial stress** in the linear elastic range. (By contrast, for **shear** deformations use the analogous Hooke's law in shear: $\tau = G\,\gamma$, where G is the shear modulus.) Do **not** use σ = Eε beyond yield – once plastic deformation begins, a different analysis is needed (the exam will specify if beyond elastic range).

Common exam pitfalls:

- **Unit mix-ups:** E is often given in GPa or psi – be careful to convert to consistent units with stress. For example, $E = 200$ GPa $= 200 \times 10^9$ Pa; if force is in N and area in m², stress comes out in Pa. Similarly 30,000 ksi means 30×10³ ksi.
- **Using the wrong modulus:** Don't confuse E (Young's modulus) with other moduli. For axial (normal) strain use E. (G is for shear, not to be used here.)
- **Forgetting linear range:** Ensure the stress given is below yield strength. If a question quietly implies yield or plastic behavior, σ = Eε would no longer hold (though such nuance is rare on FE, which usually sticks to elastic realm).
- **Distinguishing stress vs. load:** σ is not the total force – it's force **per area**. A common mistake is to plug force P directly where stress is needed or vice versa. Always divide by area to get σ, multiply σ by area to get the force if needed.

Exam Handbook Search Cues (Not affiliated with or endorsed by NCEES): "Young's modulus", "Hooke's law", "stress–strain", "modulus of elasticity"

Footnotes:

- *Engineering vs. true stress:* Engineering stress is calculated using the original cross-sectional area A_0. True stress (rarely needed in FE exams) uses the instantaneous area as the material stretches. For small strains (a few percent or less), the difference is negligible. Unless explicitly stated, assume engineering values.

- *Notation:* Common symbols for stress and strain: σ (sigma) for normal stress, ε (epsilon) for normal strain. These are typically along the length of the member for axial loading. Strain is often given in microstrain on charts (e.g. $500\ \mu\varepsilon = 5 \times 10^{-4}$).

- *Typical values:* Metals have high E (steel ~200 GPa, aluminum ~70 GPa), meaning they only strain a tiny amount under working stress. Elastomers or plastics have much lower E (MPa range), thus much larger elastic strains. On exam day, remember that a **stiffer material (higher E)** will deform less under the same load.

Variations and related forms: In the elastic regime, you can rearrange Hooke's law: $\epsilon = \sigma/E$. Also, **Poisson's effect** is related: when a material is stretched in one direction, it contracts laterally (discussed in subtopic S04). The linear relation $\sigma = E\epsilon$ is one-dimensional; the full 3D elasticity laws generalize this concept to multiple axes and relate E to other moduli like G (shear modulus) and K (bulk modulus).

Explanation & Analysis: Hooke's law is essentially the **spring behavior** for solid materials – stress is proportional to strain just like force is proportional to extension in a spring ($F = kx$). Here E plays the role of spring stiffness per unit area. This equation is used whenever you need to find how much a rod will stretch under a given stress (or vice versa). For example, if a steel rod experiences a stress of 100 MPa, the corresponding strain is $\epsilon = \sigma/E = 100 \times 10^6/(200 \times 10^9) = 5 \times 10^{-4}$ (0.05% elongation). Term-by-term: σ (stress) represents intensity of internal forces, E is a constant (for steel, ~2×10^{11} Pa) that tells how "hard to stretch" the material is, and ϵ is the resulting deformation fraction. Physically, $\sigma = E\epsilon$ means if you double the stress you double the strain – a linear response. Always check units: plugging stress in Pa and using E in Pa yields strain as a pure number. A common mistake is to forget to convert E to the correct units or to mix up N and kN, etc., leading to strain off by factors of 1000. If you keep units consistent, Hooke's law will faithfully give you the deformation behavior of materials under normal loads.

K08.T03.S02 – Axial Deformation of Members Under Load (δ = PL/AE)

Principle introduction: When a prismatic bar (uniform cross-sectional area) is pulled or compressed by an axial force, it changes length. This **axial deformation** can be calculated directly from the load, geometry, and material properties. Key insights:

- Under axial force P, the **normal stress** in a uniform bar is $\sigma = P/A$. Combining this with the linear strain from Hooke's law ($\epsilon = \sigma/E$) gives the **strain** as $\epsilon = P/(AE)$.
- Strain is also $\epsilon = \delta/L$ (change in length over original length). Thus, $\delta/L = P/(AE)$, which leads to the formula for **elongation** (or shortening) $\delta = \frac{PL}{AE}$.
- This formula $\delta = PL/(AE)$ assumes the bar's cross-sectional area A and E are constant along the length (prismatic member) and the entire bar stays elastic under the load. It essentially integrates small extensions over the length – for a constant A and E, it's just one multiplication.
- Axial deformation is **proportional** to the applied force and original length, and **inversely proportional** to the bar's cross-sectional area and modulus. Intuitively: a longer bar stretches more (more length to stretch), a larger cross-section or stiffer material stretches less (more resistance).
- Superposition applies: if a member is made of segments or experiences multiple forces, the total deformation is the sum of each part's deformation. For example, if you have sections of different materials or areas in series, compute each section's δ with its L, A, E and add them up.

Equation Passport – Axial Deformation (Elastic): Computes the change in length of a member under axial load.

Formula: $\delta = \frac{PL}{AE}$

Variables:

- δ = axial deformation (extension if P is tensile, shortening if P is compressive). Units: m (or in, etc., same as L).
- P = axial force (N or lbf) applied to the member.
- L = original length of the member (m, in).
- A = cross-sectional area of the member (m², in²).
- E = Young's modulus of the material (Pa, psi).

Assumptions & Scope:

- **Prismatic member:** A and E are uniform along the length. (If the cross-section or material changes along L, you must handle each segment separately or integrate.)
- **Linear elastic behavior:** The stress from load P must be within the elastic range for E to be constant and the formula to hold. No yielding or permanent deformation occurs.
- **Small deformation:** δ is assumed small relative to L (valid for typical elastic stretches – usually on the order of millimeters for metal rods a meter long). This ensures geometry doesn't significantly change during loading (no second-order effects).
- **Uniaxial loading only:** The member is only loaded in one direction along its axis (no bending, no significant transverse loads or thermal expansion in this basic formula).

Limit checks: If $P = 0$, then $\delta = 0$ (no load, no change in length). If the bar were twice as long (L doubled), δ doubles – which makes sense: a longer bar offers twice the stretchable length. If cross-sectional area A is huge (approaching a rigid wall thickness), $\delta \to 0$ – a very thick bar barely stretches under a given load. If E is extremely large (an extremely stiff material), δ also → 0 (think of trying to stretch a diamond rod versus an aluminum rod with the same dimensions and load – the diamond's tiny strain yields negligible elongation).

Use vs. sibling equations: Use $\delta = PL/(AE)$ for a **single, uniform segment** under axial load. If you have multiple segments in series (say a compound rod of different materials or areas), use the formula on each segment and sum the deformations: $\delta_{\text{total}} = \sum \frac{PL_i}{A_i E_i}$. If the cross-section varies continuously, the "sibling" is an integral form: $\delta = \int_0^L \frac{P}{A(x)E(x)}\,dx$. (The FE exam typically provides piecewise segments rather than requiring actual integration.) Also, contrast axial deformation with other deformations: for instance, bending deflection or torsional twist have different formulas; use

this one only for direct tension/compression along the member's axis.

Common exam pitfalls:

- **Inconsistent units:** Mixing units will ruin the result. For example, using P in kN, L in mm, A in m², and E in GPa all at once – you must convert everything to a consistent set (N, m, Pa) or use a consistent imperial set (lbf, in, psi). Keep track: E in Pa (N/m²) requires P in N, A in m², L in m to get δ in m.
- **Forgetting to divide by area or using wrong area:** Sometimes a problem gives diameters and you need to compute cross-sectional area ($A = \pi d^2/4$ for a circular rod). Using diameter directly in the formula instead of area is a mistake to guard against.
- **Sign convention confusion:** This formula gives the magnitude of change in length. If needed, assign a positive sign for elongation (tension) and negative for shortening (compression) based on context. For most exam problems, giving the magnitude and understanding tension vs compression is enough.
- **Not summing segments:** If the rod is composed of different materials or sections (e.g., a steel section and an aluminum section bolted together in line), each will have its own δ. A common error is to try to plug in an "average" E or combined length into one formula. Instead, compute each segment's deformation and add them.
- **Ignoring load changes along length:** If there are intermediate loads or supports, internal force P might change in different sections. The P in $\delta = PL/AE$ is the internal axial force in that segment. Draw a free-body diagram to identify P in each section if it's not uniform throughout.

Exam Handbook Search Cues (Not affiliated with or endorsed by NCEES): "δ = PL/AE", "axial deformation", "elongation", "deformation"

Footnotes: - *Range of validity:* $\delta = PL/(AE)$ works as long as the material stays elastic. If P is so high that the material yields, actual deformation will exceed this elastic prediction (plastic stretch added). The exam will indicate if yielding occurs; otherwise assume elastic.

- *Thermal expansion vs. load:* Keep **thermal deformation** separate – if a bar also changes length due to temperature (next subtopic), you add that change too (algebraically). For instance, total ΔL could be from both load and temperature if both effects are present (superposition applies because small deformations add).

- *Structural support effects:* In statically indeterminate problems (where supports prevent free expansion under load), you may need compatibility (deformation constraints) to solve for forces. E.g., if two different materials share a load, the requirement that they deform equally can determine how load splits. Such cases still rely on $\delta = PL/(AE)$ in forming equations, but you solve for unknown P. (This is more advanced; basic questions typically give you P directly.)

Variations and related forms: The formula can be rearranged: for example, solve for P if you know a maximum allowable stretch $\delta_{\max}$ (use $P = \frac{\delta AE}{L}$). Also, if asked for **axial stiffness** of a member, note that $k_{\text{axial}} = \frac{AE}{L}$ (because $P = (AE/L)\,\delta$, analogous to Hooke's spring $F = kx$). Typical values: a steel rod 1 m long and 1 cm² area under a 10 kN (≈1 ton) load will stretch about $\delta = \frac{10{,}000\ N \cdot 1\ m}{0.0001\ m^2 \cdot 200\times10^9\ Pa} \approx 0.0005\ m = 0.5\ mm$. So axial elastic stretches in metals are usually on the order of millimeters or less – helpful to sanity-check your answers.

Explanation & Analysis: This formula is derived by applying **Hooke's law and geometry** along the member's length. It essentially says the member behaves like a spring: $P = (AE/L)\,\delta$, so $\delta = P/(AE) \times L$. Each term's role: P (force) drives the deformation; L – a longer member gives more length to stretch (like a longer spring – easier to stretch further); A – a thicker cross-section is like a stiffer spring (more area resists the load, so less stretch); E – a stiffer material (higher E) also stretches less. If any of these factors increase or decrease, you can predict how δ changes. For instance, doubling the area A halves the deformation (all else equal). In FE exam problems, you might use this when designing rods or checking if a support will sag: e.g., "How much will a steel tie rod of length L elongate under a tensile load P?" Simply plug in. A common check: **does the result seem reasonable?** If you compute a deformation of 3 meters for a 2 meter steel rod under a modest load, something's wrong (likely units). But a few millimeters is plausible. By analyzing each term, you can catch errors: ensure P is in N, A in m², L in m, E in N/m² to get δ in m (or consistently in imperial). Remember that while the bar gets longer under tension, it actually gets a bit narrower (Poisson's effect) – but that lateral change doesn't enter this 1D formula (it's handled by ν, separately). In summary, $\delta = PL/(AE)$ gives you a quick and powerful way to predict how structures stretch or compress under axial loads – a go-to formula for axial members.

K08.T03.S03 – Thermal Strain in Members (Free Expansion and Induced Stress)

Principle introduction: Materials change size with temperature. A temperature increase typically causes expansion; a decrease causes contraction. The **coefficient of thermal expansion (α)** links temperature change to strain. Key points:

- **Free thermal expansion:** If an object is allowed to expand freely with no restraint, a temperature change ΔT produces a **thermal strain** $\epsilon_{\text{thermal}} = \alpha\,\Delta T$. This strain is linear per degree of temperature change. Multiplying by original length L gives the **change in length**: $\Delta L = \alpha\, L\, \Delta T$.
- α (alpha) is the linear expansion coefficient, typically given in units like 1/°C or 1/°F (e.g., steel $\alpha \approx 11 \times 10^{-6}$/°C). It means if $\Delta T = 1°$, the material expands by α times its length. Different materials have different α (e.g., aluminum ~23×10⁻⁶/°C, twice that of steel, so aluminum expands more for the same ΔT).
- **Thermal stress (restrained expansion):** If expansion is **restrained** (the material cannot freely change length), thermal strain creates internal stress. Imagine a rod between rigid walls: when heated, it "wants" to expand by $\Delta L = \alpha L \Delta T$, but the walls prevent any net expansion. The result is compressive stress building up in the rod, because it's effectively "squeezed" by the thermal tendency.
- For a fully constrained member, the induced **thermal stress** can be calculated by combining the thermal strain

with Hooke's law: the rod tries to have strain $\alpha\Delta T$ but actual strain is zero (no expansion), so the material experiences an elastic strain of $-\alpha\Delta T$ (negative because it's in compression) due to the restraint. By Hooke's law, this corresponds to a stress $\sigma_{\text{thermal}} = E(-\alpha\Delta T)$ in the material. In magnitude, $\sigma = E\alpha\Delta T$. This is the stress required to *prevent* the free expansion.

- Partially restrained expansion (like a spring support or a gap) will result in a smaller stress than fully fixed, but the FE exam usually focuses on the two extremes: free (no stress, just expansion) vs. fixed (no expansion, full stress). Always consider: free expansion causes no stress (structure just gets longer), while restrained expansion causes potentially large stresses (like thermal stress in bridges or rails if expansion joints aren't sufficient).

Equation Passport – Thermal Expansion: Computes the change in length of a material given a temperature change (assuming free expansion).

Formula (free expansion): $\Delta L = \alpha L \Delta T$

Variables:

- ΔL = change in length due to temperature change (m, in). Positive if expansion (heating), negative if contraction (cooling).
- α = coefficient of linear thermal expansion (units: 1/°C or 1/°F, typically a small value like 10^{-6} per degree).
- L = original length of the member (m, in).
- ΔT = change in temperature ($T_{\text{final}} - T_{\text{initial}}$, in °C or °F). Make sure ΔT is in the unit system matching α (e.g., if α is per °C, use °C for ΔT).

Assumptions & Scope:

- The material is homogeneous and the temperature change is uniform over the length. (No temperature gradients along the member – we assume the whole thing experiences the same ΔT.)
- The temperature change is moderate so that α can be considered constant over that range. (For most engineering materials, α doesn't change drastically for reasonable ΔT, and the relation remains linear.)
- No external constraints during expansion – this formula is for **free expansion** with zero stress. (If there are constraints, use this formula to find free expansion, then use compatibility/Hooke's law to find stress if needed.)
- No phase changes occur (we're not, say, melting the material; that would invalidate simple expansion formula).

Limit checks: If $\Delta T = 0$, then $\Delta L = 0$ (no temperature change, no expansion – trivial check). If $\alpha = 0$ (a hypothetical material with zero thermal expansion, like an ideal Invar at a certain temperature), then $\Delta L = 0$ regardless of ΔT – length doesn't change with temperature. If L is larger, ΔL scales up linearly – e.g., doubling the length doubles absolute expansion for the same ΔT. A 100°C temperature rise on a 1 m steel rod (α~11×10^{-6}/°C) gives $\Delta L \approx 1m * 100 * 11e-6 = 0.0011m = 1.1mm$. For 10 m of the same steel, it would be 11 mm – significant expansion.

Use vs. sibling equations: Use $\Delta L = \alpha L \Delta T$ for **thermal expansion problems** (find length change from heating/cooling). If asked for **thermal strain** instead, just use $\epsilon_{\text{thermal}} = \alpha\Delta T$ (since strain = ΔL/L). For **thermal stress when expansion is prevented**, do not use this formula alone; instead, recognize that if ΔL is forced to zero, the "would-be" thermal strain is converted into stress via $\sigma = E\,\epsilon_{\text{thermal}} = E\alpha\Delta T$. That is effectively Hooke's law applied to the thermal strain. There's no separate official formula for thermal stress in the handbook; you derive it from these principles. Also note, if only a portion of expansion is prevented (e.g., a rod can expand partially), more complex analysis is needed – but on the exam typically it's either free or fully fixed.

Common exam pitfalls:

- **Mismatched units for ΔT and α:** Ensure that if α is given per °F, your ΔT is in °F. It's easy to accidentally use a temperature in °C with an α in per °F (or vice versa) which would give the wrong answer. The exam might provide α in dual units (e.g. "α = 6.5×10^{-6}/°F (11.7×10^{-6}/°C)") – pick the appropriate one.
- **Forgetting constraint conditions:** If a problem says "both ends fixed" or "embedded between walls," don't compute a ΔL and leave it at that – in reality the ΔL is zero and instead you must find stress. Conversely, if it's free to expand, don't calculate stress (stress would be zero). Identify whether the expansion is free or restricted.
- **Sign convention:** Usually expansion is indicated as positive ΔL. If the temperature drops (ΔT negative), ΔL comes out negative (length shrinks). Be mindful interpreting the sign: a negative ΔL means the member gets shorter. If a question asks "by how much does the length increase?" and ΔL comes out negative, the answer would be that it actually decreases by that magnitude.
- **Combining with other strains:** Sometimes a member might be under load and temperature change simultaneously. A common mistake is to forget one or the other. Superposition applies: total strain = mechanical strain (P/AE) + thermal strain (αΔT). If the member is constrained and loaded, you may need to consider both stress from load and stress from thermal expansion together.
- **Assuming zero thermal strain if not mentioned:** If a problem involves a large temperature change and doesn't explicitly mention it, it's usually safe to ignore thermal effects unless prompted. However, if given α and ΔT, the exam is hinting you to use them.

Exam Handbook Search Cues (Not affiliated with or endorsed by NCEES): "thermal expansion", "α L ΔT", "coefficient of thermal expansion", "thermal stress"

Footnotes:

- *Isotropic expansion:* α given is linear (in one dimension). For uniform expansion in all directions (like area or volume change), the coefficients differ (approximately 2α for area, 3α for volume for small strains). The FE Mechanical is typically concerned with linear expansion in structural members (rods, beams) rather than volumetric expansion.

- *Thermal strain in 3D:* In a multi-axial context, thermal strain adds to each normal strain component (see next subtopic). If a body is heated uniformly in all directions and free, it just expands with no

stress; if parts are constrained, thermal stresses can develop along those constrained directions.

- *Material selection:* Engineers sometimes choose materials with low α (like Invar alloy) when dimensional stability under temperature is critical. Conversely, in assemblies of different materials, differing α can cause thermal strain mismatch – but that's beyond the FE exam's depth.

- *Expansion joints:* In structures like bridges or railroads, thermal expansion can create huge forces if not accommodated. The exam might not directly ask design of expansion joints, but it's good context: always allow something to freely expand if you want to avoid thermal stress.

Variations and related forms: If asked for final length after temperature change (and free expansion), you'd do $L_{\text{final}} = L + \Delta L = L\,(1 + \alpha\Delta T)$. For multiple materials rigidly connected (e.g., a bimetallic strip or a compound rod), each material tries to expand differently – that can induce internal forces between them (a bit complex; FE questions on this are usually qualitative). Thermal stress formula $\sigma = E\alpha\Delta T$ assumes full restraint – any partial restraint would yield a stress smaller than this value. Typical values: for steel, $\alpha \approx 12 \times 10^{-6}/°C$, a 50°C rise in a 5 m beam (free) gives ΔL ≈ 5 m * 50 * 12e-6 = 0.003 m (3 mm). If that 5 m beam were locked in place, the stress induced would be $\sigma \approx E\alpha\Delta T = 200\text{ GPa} * 12e-6 * 50 \approx 120\text{ MPa}$ (a significant stress, about half of steel's yield strength!). This illustrates why accounting for thermal expansion is important – the exam may test your ability to compute such stresses or expansions.

Explanation & Analysis: Thermal strain is conceptually simple: heat a rod and it gets longer; cool it and it gets shorter. The equation $\Delta L = \alpha L\Delta T$ gives a direct handle on this effect. Each variable's role: ΔT is the driving cause (how much temperature changes), α is a material property (how responsive the material is to temperature – large for aluminum, small for glass or ceramics), and L is the length that's expanding. The product $\alpha\Delta T$ is a strain (e.g. 0.001 means 0.1% expansion), and multiplying by L yields the actual length change. On the exam, you may get a straightforward question: *"A 2 m aluminum rod undergoes a 30°C rise, how much longer does it get?"* – plug into ΔL = αLΔT. The trickier part is when expansion is **constrained**. Then, conceptually, the rod "pushes" against the restraints as it tries to expand. Think of it like this: if a rod would freely expand 3 mm but is held fixed, it's as if the rod is compressed by 3 mm relative to its free state. That 3 mm compression (over original length) is a strain of $-\alpha\Delta T$, which by Hooke's law corresponds to a compressive stress. Always determine: is it free (then just expansion, no stress) or fixed (then no expansion, compute stress)? In summary, use $\alpha L\Delta T$ to get expansion when free, and $E\alpha\Delta T$ to get stress when expansion is prevented. Remember to apply sign logic: a heated restrained rod is in **compression** (it wants to expand, walls push it back in), whereas a cooled restrained rod would be in **tension** (it wants to contract, walls pull it). Thermal strain problems often combine nicely with the earlier formulas – just superimpose the thermal ΔL with any load-induced ΔL for total deformation. Keep an eye on units and whether the problem expects an answer in mm or in (a quick mental estimate helps avoid answers off by a factor of 1000). Thermal effects are straightforward once you categorize the scenario correctly.

K08.T03.S04 – Generalized Linear Elasticity in 3D (E, G, ν Relations & Thermal Strains)

Principle introduction: Real structures experience multi-axial stress states – even a simple axial pull causes lateral contraction. **Generalized Hooke's law** extends the stress–strain relationship to three dimensions, and for isotropic materials it introduces two key material constants: **Young's modulus (E)** and **Poisson's ratio (ν)** (from these, other moduli like shear modulus G and bulk modulus K are determined). Key points:

- **Poisson's ratio (ν):** When you stretch a material in one direction (say the x-axis), it tends to contract in the perpendicular directions (y and z axes). Poisson's ratio is defined as $\nu = -\frac{\epsilon_{\text{lateral}}}{\epsilon_{\text{axial}}}$ for uniaxial loading – essentially the ratio of lateral shrinkage strain to longitudinal extension strain (the negative sign makes ν positive, since lateral strain is negative for a positive axial strain). Most engineering materials have ν between 0 and 0.5 (e.g., steel ~0.3). A ν of 0.3 means if a rod elongates by 1%, it will contract by 0.3% in width. ν = 0.5 is the theoretical upper limit for incompressible materials (volume constant during deformation, like rubber approximately).
- **Shear modulus (G) and relation to E, ν:** The shear modulus G (also called **modulus of rigidity**) relates shear stress to shear strain (τ = Gγ). For isotropic materials, G is not independent; it is linked to E and ν by $G = \frac{E}{2(1+\nu)}$. This means if you know any two of E, G, and ν, you can find the third. For example, given $E = 210$ GPa and $\nu = 0.3$, $G \approx \frac{210}{2(1.3)} \approx 81$ GPa.
- **Bulk modulus (K):** Another modulus for volumetric elasticity (how a material resists uniform compression). It relates pressure to volumetric strain and is $K = \frac{E}{3(1-2\nu)}$. Though less commonly needed in basic problems, know it exists; incompressible materials (ν→0.5) make $1 - 2\nu \to 0$, so K → ∞ (volume won't change under pressure). The FE Mechanical might not directly ask for K, but it completes the set of moduli.
- **Generalized Hooke's Law in 3D:** In an isotropic elastic material, the stress in one direction influences strains in all directions. The 3D stress–strain relationships (for small strains) can be written as:

$$\varepsilon_x = \frac{1}{E}\left[\sigma_x - \nu\left(\sigma_y + \sigma_z\right)\right] + \alpha\,\Delta T,$$
$$\varepsilon_y = \frac{1}{E}\left[\sigma_y - \nu(\sigma_x + \sigma_z)\right] + \alpha\,\Delta T,$$
$$\varepsilon_z = \frac{1}{E}\left[\sigma_z - \nu\left(\sigma_x + \sigma_y\right)\right] + \alpha\,\Delta T.$$

  (The last term $\alpha\Delta T$ is included if a uniform temperature change occurs, introducing free expansion strain in each direction.) These equations say: strain in a given direction comes from the direct stress in that direction minus ν times the stresses from the other two directions (since those cause opposite strain due to Poisson effect), plus any thermal strain.
- **Special cases:** If stress is only in one direction (uniaxial stress, σx = P/A, σy=σz=0), these formulas reduce to: $\varepsilon_x = \sigma_x/E$ (Hooke's law in that direction), and $\varepsilon_y = \varepsilon_z = -\frac{\nu\,\sigma_x}{E}$ (lateral contractions). If a temperature rise is also present, add $\alpha\Delta T$ to each (so $\varepsilon_x = \sigma_x/E + \alpha\Delta T$, etc., and if fully unrestrained, σx might be zero but still αΔT causes strain). If all three normal stresses are equal (hydrostatic stress condition), the strains in each direction are $\varepsilon = \frac{1-2\nu}{E}\sigma + \alpha\Delta T$; for a pure thermal expansion (no stress), put σ=0 and recover $\varepsilon = \alpha\Delta T$ as expected.

Equation Passport – Elastic Moduli Relationships: Ties together the material constants for isotropic linear elasticity.

Formulas:
$G = \frac{E}{2(1+\nu)}$ (shear modulus relation)
$K = \frac{E}{3(1-2\nu)}$ (bulk modulus relation)

Variables:

- E = Young's modulus (Pa, psi) – stiffness in tension/compression.
- G = shear modulus (Pa, psi) – stiffness in shear.
- K = bulk modulus (Pa, psi) – stiffness in uniform compression (volumetric).
- ν = Poisson's ratio (dimensionless).

Assumptions & Scope:

- Material is **isotropic** (same properties in all directions). These relations do not hold for anisotropic materials (like composites or wood) which have more independent elastic constants.
- Linear elasticity is valid (constants E, G, ν remain constant under the given stress state).
- These formulas are purely material relationships – independent of shape. Any isotropic material's moduli will satisfy them. They are typically provided or can be derived; you won't usually have to derive them on exam, but you should know how to use them.

Limit checks & behavior:

- As ν approaches 0.5 (incompressible limit), note $G = E/[2(1.5)] \approx 1/3E$. If ν=0.5 exactly, K would be infinite (which is consistent: incompressible material cannot be volumetrically compressed).
- If $\nu = 0$ (no lateral strain – a hypothetical perfectly Poisson-less material), then $G = E/2$ and $K = E/3$.
- Metals typically: ν ~0.25–0.35, so G is around $E/2.6$ to $E/2.9$. For example, steel with E=200 GPa and ν=0.30 gives $G \approx 77$GPa (which matches typical steel shear modulus data).
- These relations must give physically meaningful positive moduli: note that having ν outside 0–0.5 can lead to negative or unrealistic G or K, which is not physical. (FE won't test that in depth, but it's good to know normal ranges.)

Use vs. sibling equations: Use $G = E/\big(2(1+\nu)\big)$ when you need to find the shear modulus but only have E and ν (or vice versa). For instance, the exam might give you ν and E and ask for the angle of twist in a shaft – you'd need G for τ = Gγ or torsion formulas. Use the 3D Hooke's law formulas (given above) to relate multi-axial stresses and strains if needed, but often the exam tests simpler cases like: *"a rod is stretched, find lateral strain"* (use $\varepsilon\varepsilon_{lat} = -\nu\varepsilon_{axial}$) or *"given E and ν, find the decrease in diameter"*. If dealing with plane stress or plane strain conditions, know that these formulas still hold for material constants, but the stress–strain relations adjust (ex: in plane stress, σz=0, which simplifies εx, εy formulas).

Common exam pitfalls:

- **Mixing up E and G:** They are different! If a problem gives G and asks for a normal stress/strain, you likely need to first compute E or use ν appropriately. Don't plug G where E is required.
- **Using the wrong Poisson formula:** Remember lateral strain is $-\nu$ times the axial strain for a uniaxial stress case (the negative sign denotes contraction). If a bar elongates by +0.001 (0.1%), and ν=0.3, the lateral strain is -0.0003 (a 0.03% contraction). A common mistake is to forget the negative and report a lateral expansion. Also, ensure you apply ν to strain ratios, not stress ratios (ν is strain-based definition; though in uniaxial case $\sigma_y/\sigma_x = \nu$ is not correct, rather $\varepsilon_y/\varepsilon_x = -\nu$).
- **Forgetting thermal strain in multi-axial problems:** If a question involves thermal expansion in a restrained multi-axial scenario, remember to add αΔT to the strain expressions. In the exam reference, the 3D formulas with thermal terms are given – if you see αΔT mentioned, it's a clue to include thermal strain.
- **Plane stress/strain confusion:** In plane stress ($\sigma_z = 0$), the 3D equations simplify: e.g., $\varepsilon_x = \frac{1}{E}\left[\sigma_x - \nu\sigma_y\right] + \alpha\Delta T$ (since $\sigma_z = 0$). In plane strain ($\varepsilon_z = 0$, often ν effects make σ_z nonzero), an effective E and ν are used. The exam might give formulas or expect understanding of those cases. Keep straight which scenario you're in. If not specifically mentioned, assume full 3D or uniaxial as appropriate.

Exam Handbook Search Cues (Not affiliated with or endorsed by NCEES): "Poisson ratio", "shear modulus G = E/(2(1+ν))", "bulk modulus", "εx = (σx – ν(σy+σz))/E"

Footnotes:

- *Poisson's ratio units:* It's unitless. Sometimes exam answers for ν are just a number (like 0.30). If a calculated ν comes out greater than 0.5 or negative for a stable material, something's wrong (likely a calculation error – e.g., confusing lateral with axial strain magnitude).

- *Material examples:* Typical ν: Steel ~0.3, Aluminum ~0.33, Concrete ~0.2 (and concrete can effectively have ν ~0 in some models since it cracks in tension), Rubber ~0.49, Cork ~0 (cork doesn't expand sideways when squeezed, making it great for bottle stoppers!). Knowing these isn't required, but it helps in estimates – you wouldn't expect a metal to have ν = 0.1 or 0.8.

- *3D Hooke's law origins:* The form $\varepsilon_x = \frac{1}{E}\left[\sigma_x - \nu\big(\sigma_y + \sigma_z\big)\right]$ comes from the superposition of one stress causing strain in its direction and ν times strain in orthogonal directions due to other stresses. It's essentially three equations that can be inverted to relate stresses from strains too (for completeness, the inverse relations are $\sigma_x = E\left[(1-\nu)\varepsilon_x + \nu\varepsilon_y + \nu\varepsilon_z\right]$ and cyclic permutations). You likely won't need the matrix inversion on the FE, but it's good to recall one form or the other.

- *Thermal strain in 3D:* The term $\alpha\Delta T$ gets added to each normal strain equation because if you raise the temperature, even with no stress, you get that much strain. In a constrained scenario, the available strain for mechanical deformation is reduced by αΔT (or if fully constrained, mechanical strain is the negative of αΔT to net to zero total strain).

Variations and related forms: Be aware of **lateral contraction formula**: for a uniaxially loaded rod, $\epsilon_{\text{lat}} = -\nu\epsilon_{\text{axial}}$ and if you need change in diameter: $\Delta d = d\,\epsilon_{\text{lat}}$ (negative for a decrease). Also, **angle of twist vs. shear strain:** sometimes you get shear modulus G from E and ν, then use it in torsion formulas. The **relation between E, G, ν** is provided in the handbook and is often directly tested – e.g., *"Given E and ν for a material, what is the shear modulus?"*. Typical values to keep in mind: for steel, E ~200 GPa, ν ~0.3, so G ~77 GPa; for aluminum, E ~70 GPa, ν ~0.33, so G ~26 GPa. If your computed G is not in a realistic ballpark (like greater than E or much smaller fraction than ~E/3 for a metal), recheck the math. Finally, remember **Hooke's law in shear**: $\tau = G\gamma$, and that in a pure shear stress state (like torsion) there is no direct ν effect because no axial stress is causing lateral strain – ν mainly couples normal stresses and strains.

Explanation & Analysis: In 3D elasticity, knowing E alone isn't enough – you need ν to describe how a material behaves when pulled or compressed, because materials deform in all directions. The FE exam typically keeps it simple: you might compute a lateral strain or a shear modulus. For instance, a question may state: *"A steel rod (E = 200 GPa, ν = 0.30) is stretched to an axial strain of 500 με. What is the lateral strain?"* You'd answer $-0.30 \times 500\mu\varepsilon = -150\mu\varepsilon$ (a contraction). Or, *"Given E and ν, find G"* – just plug into $G = E/[2(1+\nu)]$. These are straightforward if you remember the relationships. Each term in the 3D Hooke's law formula has a physical meaning: σ_x/E is the direct strain from σx, while $-\nu\sigma_y/E$ and $-\nu\sigma_z/E$ are the strains induced in x due to y and z stresses (they are subtractive because a positive σy or σz – tensile in those directions – would make the material want to shrink in x). The thermal term $+\alpha\Delta T$ simply adds expansion in each direction for a temperature rise (or contraction for a drop). A common sense check: if ν = 0, the formulas decouple – $\epsilon_x = \sigma_x/E$ (no lateral influence), and $G = E/2$. If ν is very high (approaching 0.5), materials become very "poisson-active," squeezing much in other directions when stretched, and G becomes relatively small compared to E (material is easier to shear than to compress). On the exam, use the given values and be careful with units (E and G must be in same units). If solving for ν given E and G, do $\nu = \frac{E}{2G} - 1$. For example, if E = 70 GPa and G = 26 GPa, then ν ≈ 70/(2*26) - 1 ≈ 1.346 - 1 = 0.346 (so ν ~0.346). It's also important to recognize scenarios: if a problem describes a biaxial stress state (stress in two directions) and asks for strain in one direction, use the generalized Hooke's law formula. Usually, though, FE problems stick to either one-dimensional cases or using the moduli relations. In summary, generalized linear elasticity** provides the tools to handle combined stresses: you've got E and ν linking normal stresses to strains, G linking shear, and α for thermal strains. Keep these relations at your fingertips, and multi-axial problems will reduce to plugging into the right formula.

Topic 04 - Stress and Strain Caused by Bending Loads

Topic Introduction: Bending loads occur whenever forces or moments make a beam or shaft bend. Under bending, materials develop **internal stresses (tension/compression and shear)** and experience **deflection (bending deformation)**. This topic is crucial for the **FE Mechanical Exam** because many questions involve beams under loads – for example, finding the maximum bending stress in a girder or the deflection at the center of a shaft. You'll need to confidently use beam formulas to solve these quickly on exam day. Typical question scenarios include: determining the **flexural stress** at a point in a beam given a moment, computing the **shear stress** in a beam's web due to a shear force, calculating the **deflection** of a beam under a standard load case (like a uniform load or a point load), or using **superposition** to combine effects of multiple loads. Mastering this topic means you can identify the correct formula (often by searching the exam handbook for keywords) and apply it with proper units and understanding of assumptions. Let's break down each subtopic in "Stress and Strain caused by Bending Loads" and equip you with a clear, exam-ready grasp of the fundamentals.

K08.T04.S01 – Flexural (Bending) Stress in Beams

Principle Introduction:

- When a beam bends, one side of its cross-section is in tension and the opposite side is in compression. The **flexural stress** varies linearly from the neutral axis (zero at neutral axis) to a maximum at the outer fibers.

- We use the **Flexural Formula** to calculate this bending stress at a distance from the neutral axis. It's derived from the internal bending moment equilibrium and the assumption that plane sections remain plane.

- In practical terms, this formula lets you find the **maximum normal stress** in the beam due to bending moment M. On the FE exam, you might use it to check if a beam's stress is below yield or to find the required section modulus for a given allowable stress.

- The formula applies to **homogeneous, linear-elastic beams** with a constant cross-section. It assumes no significant axial loads and that the material follows Hooke's law (so stress is proportional to strain up to yield).

Exam Handbook Search Cues (Not affiliated with or endorsed by NCEES): *bending stress; Mc/I; section modulus; neutral axis* (Searching these terms in the exam handbook will point you to the bending stress relations.)

Footnotes:

- Units: M (moment) in N·m (or ft·lb in US units), I (second moment of area) in $m^4 (in^4)$, c or y in m (in). The resulting stress σ comes out in Pascals (Pa) or psi. Always keep unit consistency (convert lengths to m if E is in Pa, etc.).

- Sign convention: By convention, **positive** M (sagging) causes **tensile stress** at the bottom fiber and compressive at the top fiber for a beam loaded downward. The formula $\sigma = \frac{My}{I}$ gives a positive value for whichever side is in tension (take y positive in the direction where tension occurs). On the exam, you usually report the magnitude of maximum stress and note if it's tension or compression.

- Scope: Valid as long as the material remains elastic (no permanent deformation). At very high moments that cause yielding, this linear formula no longer holds – but the FE exam stays within elastic analysis.

- The neutral axis is the line in the cross-section where the bending stress equals zero. It passes through the centroid for homogeneous materials. Ensure you calculate c (distance from neutral axis) correctly for asymmetrical sections: it's the larger of the distances from centroid to top or bottom fiber for max stress.

Variations & Related Forms:

- **Section Modulus Form:** The formula is often written as $\sigma = \frac{M}{S}$, where $S = \frac{I}{c}$ is the **section modulus** of the beam's cross-section. This form directly gives the maximum stress at the extreme fiber using c. It's handy for design: you can solve $S = M/\sigma_{\text{allow}}$ to choose a beam size.

- **Alternate Symbols:** Sometimes y is used instead of c for the distance to a specific fiber. For maximum stress, use $y = c$ (outermost fiber). The exam handbook uses both forms (Mc/I and M/S); they're the same relation.

- **Symmetric vs. Asymmetric Sections:** For doubly symmetric sections (like I-beams or rectangular beams), the neutral axis is at mid-depth, and the top and bottom experience equal magnitude stress (tension vs compression). For non-symmetric sections (e.g. T-sections), you calculate two different c values (top and bottom) to find both tensile and compressive extreme stresses.

- **Composite Beams:** (Beyond basic scope) If a beam is made of two materials (e.g., steel+wood), you use a *transformed section* to still apply $\sigma = My/I$ with an equivalent I. This is mentioned in advanced contexts but typical FE questions keep to single-material beams.

Explanation & Analysis: The *flexural stress formula* is one of the most fundamental beam equations:

Equation Passport – Flexural Stress (Bending Formula) – computes the normal stress at a distance y from the neutral axis in a beam under bending moment.

Equation: $\sigma_b(y) = \frac{M\,y}{I}$

Variables & Units:

- M – internal bending moment at the cross-section (units: N·m or lb·ft)
- y – distance from the neutral axis to the point of interest (m or ft). By convention, y is positive in the direction where the bending moment causes tension. The maximum value is $y = c$, the distance to the outermost fiber.
- I – second moment of area of the cross-section about the neutral axis (m^4 or in^4).
- σ_b – bending (normal) stress at that fiber (Pa or psi).

Assumptions & Scope:

- Material is homogeneous and linearly elastic (obeys Hooke's law).

- Under the Bernoulli–Euler assumption, the cross-section stays plane and remains perpendicular to the beam's neutral axis after bending (i.e., no out-of-plane warping).

- Deflections are small (beam geometry doesn't significantly change under load).

- The formula gives *elastic* stress distribution. It doesn't account for plastic behavior or stress concentrations.

Limit Checks (Sanity Tests):

- As $y \to 0$ (approaching the neutral axis), $\sigma_b \to 0$. That makes sense – no fiber strain at the neutral axis.

- As $I \to \infty$ (very stiff, large I section), $\sigma_b \to 0$. A huge moment of inertia means the beam is very resistant to bending (tiny stress for a given M).

- As c (outer fiber distance) increases for a fixed I (i.e., thin tall section vs. compact section), maximum stress increases. This is why deeper beams (larger c) need larger I to reduce stress – captured by $S = I/c$.

Use vs. Sibling Equations: Use the flexural formula $\sigma = My/I$ for **normal stress due to bending**. Use this instead of axial stress formulas (like $\sigma = P/A$) when the load causes bending, not uniform tension/compression. Do **not** use it for torsional shear (that's a different formula), or for transverse shear (use VQ/It for shear stress, see next subtopic).

Common Exam Traps:

- **Mixing up y and I:** Don't plug the entire area or moment of inertia into the numerator. It's M times *distance* y, divided by I – not M times area. I is a geometric property of the cross-section (e.g., for a rectangle $I = bh^3/12$ about centroidal axis).

- **Units mistakes:** If M is in kip-ft and I in in^4, convert to consistent units (e.g., kip-in). Or convert everything to base units (in, lbf) to get stress in psi. A common mistake is using M in N·m with I in cm^4 – convert cm^4 to m^4 or M to N·cm. On exam day, do a quick unit check – the result should be a stress unit.

- **Sign confusion:** The formula gives a positive or negative value depending on the assumed sign convention (tension vs compression). If the question just asks for "the bending stress" magnitude, provide it as positive with a note of it being tensile or compressive. Watch the sign if they specifically ask which face is in tension.

- **Using the wrong c:** For an I-beam, c is the distance from neutral axis to the top *or* bottom fiber (they're equal if symmetric). For a T-beam or unsymmetric section, identify which fiber has the larger distance – that's where max stress occurs. Students sometimes plug in half the depth by mistake when the neutral axis isn't at mid-depth.

Application Perspective: This formula essentially tells you that bending stress grows linearly with distance from the neutral axis. Intuitively, imagine bending a ruler – the top side stretches (tension) and bottom side squishes (compression) the most at the outer surfaces, while the middle doesn't stretch at all (neutral axis). The further from the neutral axis, the more strain and thus more stress (until material yields). On the FE exam, **you'll typically use $\sigma = Mc/I$ to find the maximum tensile or compressive stress in beams** under given loads. For example, if a simply supported beam has a certain moment M at midspan, you'd calculate c (half the depth if symmetric) and I (from geometry or given), then compute $\sigma_{\max} = Mc/I$. If the problem gives allowable stress, you might do the reverse: solve $M = \sigma_{\text{allow}}(I/c)$ to find how much moment the beam can carry. Remember that I/c (section modulus S) is often tabulated for standard shapes – using that can save time. **Practice Move:** It's wise to practice computing I for simple shapes (rectangle, circle) and identifying c, so you're comfortable plugging numbers quickly. But also remember on exam day, the *handbook provides common formulas* for I of basic shapes and lists of section properties – you don't have to derive them from scratch. The key is knowing *when* to apply the bending stress formula and interpreting the results (e.g., tension vs compression, comparing to yield strength).

K08.T04.S02 – Transverse Shear Stress in Beams

Principle Introduction:

- Bending loads not only induce normal (flexural) stress but also **transverse shear stress** in beams. When a beam carries a shear force V at a cross-section (due to loads that create bending), the material must internally **shear** to transmit that force. The shear stress is typically highest near the neutral axis and zero at the extreme fibers.

- We calculate shear stress using the **shear formula** $\tau = \frac{VQ}{It}$ (also written $\tau = \frac{VQ}{Ib}$ for a beam of width b). This formula gives the internal shear stress at a specific horizontal layer of the cross-section, due to the shear force V.

- Q is the first moment of the chosen portion of the cross-section about the neutral axis (area of that portion times the distance from its centroid to the neutral axis) where we're finding τ. In simpler terms, to find shear stress at some point in the cross-section, consider the area from that point to the top (or bottom) of the cross-section – that area times its distance to neutral axis is Q. The larger the Q (meaning more area is being sheared off above that layer), the more shear stress at that layer.

- This formula is most commonly applied to determine the **shear stress distribution** in beam cross-sections. For example, in a rectangular beam, it predicts a parabolic shear stress distribution, with maximum τ at the neutral axis. In thin-webbed beams (I-beams, T-beams), it helps find shear stress in the web and how much shear flows into flanges.

- On the FE exam, you may need to calculate the **maximum shear stress** in a given cross-section or the shear stress at a specific location. Often, if the cross-section is simple (rectangle, circle, I-beam web), the problem expects you to know or quickly derive the shear at neutral axis or use the average shear and shape factor. It's less common but possible to see a question on **shear flow**, which is related (used for built-up sections or finding bolt forces in flanges).

Exam Handbook Search Cues (Not affiliated with or endorsed by NCEES): *shear stress in beam; VQ/It; first moment of area Q; shear flow*

Footnotes:

- **Units:** V is a force (N or lb), Q is area×distance (e.g., m^3 or in^3 if area in m^2 and distance in m), I is area moment (m^4), and t (or b)

is width (m). The result τ is in Pa (N/m²) or psi. The formula inherently gives an **average** shear stress across the thickness t at that layer. In a rectangular section, t is the width b of the section at the layer of interest (constant for rectangle). In an I-beam web, t would be the web thickness when computing web shear stress.

- **When to use average vs. max:** Sometimes the exam might give you a shear force and ask for "average shear stress" – that's simply V/A (total shear divided by cross-sectional area). The formula $\tau = VQ/It$ gives the **actual shear stress at a specific location**; its maximum for a given cross-section often occurs at the neutral axis. For a rectangular section, $\tau_{\max} = 1.5(V/A)$ at the neutral axis (50% higher than the average V/A). Be careful to distinguish when a problem wants the distribution (use VQ/It) versus a simple average shear.

- **Shear vs. Bending dominance:** In many beam problems, bending stress is the primary design factor (much larger than shear stress). However, for short/deep beams or at supports of beams with high shear, the shear stress can be significant. The FE exam could test that by asking for shear stress calculation in a thick pin or a short beam where shear isn't negligible.

- **Q calculation tip:** $Q = A'\bar{y}$, where A' is the area of the portion of the cross-section *above* (or below) the level where you're finding τ, and $\bar{y}$ is the distance from that portion's centroid to the neutral axis. For maximum shear in symmetric shapes, take the top half area (or bottom half) above the neutral axis. It's easy to make errors computing Q under exam pressure – double-check by sketching the cross-section and shading the area used for Q.

Variations & Related Concepts:

- **Shear Flow (q):** Shear flow is defined as $q = VQ/I$ (with no t in the formula). It has units of force per length (N/m or lb/in) and represents how force "flows" along the beam at a given horizontal slice. It's especially useful for built-up sections: for example, in an I-beam, q at the junction of the flange and web tells you how much shear force is transferred between them (important for rivets or weld design). If you know q and the thickness t at that location, $\tau = q/t$. In a thin web, q is roughly constant across the web height, and dividing by web thickness gives the shear stress in the web.

- **Rectangular Section Special Case:** As noted, a rectangular cross-section has a parabolic shear stress distribution. The formula yields $\tau_{\max} = \frac{3}{2}\frac{V}{A}$ at the neutral axis, and $\tau = 0$ at the top and bottom surfaces. The exam might expect you to know the 1.5 factor for max shear in a rectangle. For other common shapes: a circular cross-section has $\tau_{\max} = \frac{4}{3}\frac{V}{A}$ at the center. The exam handbook provides VQ/It generally rather than these factors, but recognizing these ratios can save time.

- **Built-up Beams:** If a beam is built by connecting plates (like a flitch beam or a box beam), shear flow q helps determine how much shear each part carries and the fastener forces. This is an advanced application – an FE question could, for instance, ask for the shear flow between two materials or the force in one bolt given a shear flow per length. The key is to compute $q = VQ/I$ for the interface and multiply by the spacing or length as needed to get force.

- **Shear in Thin-Walled Sections:** For very thin sections (like sheet metal or thin-walled tubes), an assumption is that shear stress is almost uniform through the thickness, and you often calculate shear flow around the wall. Again, this is more in-depth than most FE questions, but the formula is the same at heart.

Explanation & Analysis: Let's formalize the shear stress formula:

Equation Passport – Transverse Shear Stress in Beams – computes the internal shear stress at a specific horizontal cut of a beam's cross-section carrying shear force V.

Equation: $\tau = \frac{VQ}{It}$

(For a rectangular cross-section, t is the breadth b of the section at the layer of interest. Sometimes written $\tau = \frac{VQ}{Ib}$ equivalently.)

Variables & Units:

- V – internal shear force at the cross-section (N or lb). This comes from the shear diagram; it's the net transverse force the section must carry.

- Q – first moment of area about the neutral axis for the part of the cross-section above (or below) the level where τ is evaluated (units of m^3 or in^3, since it is area multiplied by a distance). For example, to find τ at the neutral axis, take the area of the top (or bottom) half of the cross-section times the distance from that half's centroid to the neutral axis.

- I – second moment of area of the whole cross-section about the neutral axis (units of m^4 or in^4).

- t – the thickness of the material at the layer (m or in). For a rectangle, t is the full width b. For an I-beam, if finding shear stress in the web, t is the web thickness (since the web carries most of the shear).

- τ – transverse shear stress at that layer (Pa or psi).

Assumptions & Scope:

- The beam is prismatic (constant cross-section) and the material is linear-elastic.

- The formula comes from shear flow distribution under the assumption that shear stress is relatively uniform across the thickness at a given horizontal layer (which is reasonable if thickness is small relative to depth).

- No significant stress concentrations or nonlinear shear behavior (this is elastic shear stress, not exceeding yield).

- For *very short or deep beams*, shear deformation might be non-negligible, but this formula still applies; it's just that deflection formulas would need shear correction (beyond FE exam scope).

Limit Checks:

- At the very top or bottom surface of any cross-section ($Q = 0$ above that layer), $\tau = 0$. That fits the reality that free surfaces can't support transverse shear stress (it must drop to zero at a free boundary).

- The maximum τ usually occurs at or near the neutral axis where Q is largest. For example, a rectangle's Q is maximal at mid-depth, giving highest τ there. If y is distance from neutral axis, Q is symmetric and largest at $y = 0$.

- If $V = 0$ (no shear force, perhaps at a free end or midspan of a symmetrically loaded simple span), then $\tau = 0$ everywhere, which makes sense.

- If the cross-section is very wide (t large) but shallow (I small), this formula shows τ can be large – which is logical: a flat, thin beam (plate) in bending has more trouble carrying shear (like shearing a deck of cards) compared to a taller beam.

Use vs. Alternatives: Use $\tau = VQ/It$ to find *internal shear stress distribution* in a beam's cross-section. It should be used instead of the simplistic $\tau = V/A$ when you need the stress at a particular location or the maximum stress. Use the simpler average $\tau = V/A$ only when asked for average shear or as a rough check. For torsional shear in circular shafts, use $\tau = Tr/J$ (different situation). For bending normal stress, revert to $\sigma = My/I$. These formulas address different internal force effects and shouldn't be interchanged.

Common Exam Traps:

- **Miscomputing Q:** This is the #1 source of error. Remember Q is *area* times *distance*. For a rectangle's neutral axis layer, Q is half the area times the distance from the centroid of that half to the neutral axis (which is $h/4$ for a full height h rectangle). That gives $Q = (b \cdot h/2) \cdot (h/4) = bh^2/8$. Many students forget the centroid distance and erroneously use $A/2$ times maybe half the depth. Take a moment to carefully compute Q, it can help to write down A' and $\bar{y}$ separately.

- **Using the wrong thickness (t):** If you're finding shear stress in the web of an I-beam, t is the web thickness, not the flange width. Conversely, if you were somehow looking at shear in the flange (unusual, since flange is typically at top/bottom where shear is near zero), you'd use flange thickness. Always use the thickness of material where the shear is acting.

- **Plugging in** y **instead of** Q**:** The formula needs the first moment Q, not just the distance y. Sometimes students mistakenly put y (distance to neutral axis) in the numerator. That's dimensionally wrong (m vs m^3). Q already has areadistance; if you only have one layer's distance, you're missing the area above it.

- **Forgetting extreme fiber values:** By the formula, at the extreme top or bottom ($Q = 0$), $\tau = 0$. That means maximum shear is not at the outer fiber (unlike bending stress). If a problem asks for shear stress at the top surface, the answer is zero. If it asks for maximum shear stress, find at neutral axis (for symmetric shapes). Some examinees mix this up because bending stress works opposite (max at surface). Remember: bending σ max at surface, shear τ max at mid-depth (for common shapes).

- **Unit issues:** If using US units, say V in kips and I in in^4, make sure to convert V to lb (multiply by 1000) or I to ft^4 appropriately so that τ ends in psi. Similarly, if areas are in cm^2 and lengths in mm, get everything to a consistent unit system. Shear stress often has large numbers (e.g., Pa), so keep track of unit scale (MPa vs Pa).

Practical Insight: Shear stresses in beams are often overlooked because design is usually governed by bending. But on the FE, a question might directly target this formula to ensure you understand shear distribution. For instance, you might be given a rectangular beam with a known shear force and asked for the shear stress at mid-depth – you'd apply $\tau = \frac{VQ}{Ib}$, with Q as described. If it's a quick conceptual question, they might simply expect you to know that $\tau_{\max} = 1.5\,V/A$ for a rectangle (so you plug in numbers quickly).

Shear flow might appear in a question about how much load a glue or a set of rivets must carry between a flange and web; you'd compute $q = VQ/I$ at that interface and then multiply by the length of the interface or spacing between fasteners to get force per fastener. The key takeaway: **don't panic if you see VQ/It** – identify the cross-section shape, compute its I and the relevant Q, and plug in carefully. It's straightforward arithmetic once you've correctly identified each term. And of course, use the exam reference: the formula $\tau = VQ/It$ is given (with definitions) in the mechanics of materials section of the handbook, so you mainly need to know how to find Q for the given situation.

K08.T04.S03 – Beam Deflection Equation and Integration Method (Euler–Bernoulli Beam Equation)

Principle Introduction:

- When loads bend a beam, not only do stresses occur, but the beam **deflects** (curves). The relationship between the applied load, the internal forces, and the deflected shape is given by the **Euler–Bernoulli beam theory**. The core of this theory is a differential equation relating bending moment and deflection.

- The **Euler–Bernoulli Beam Equation** is commonly written as $EI\frac{d^2v}{dx^2} = M(x)$, where $v(x)$ describes the deflection of the beam as a function of position x along the beam. In words: the bending moment at a given point is proportional to the curvature of the beam at that point (curvature is d^2v/dx^2) times the flexural rigidity EI.

- By differentiating this relation, we can also say $EI\frac{d^3v}{dx^3} = V(x)$ (the internal shear force) and $EI\frac{d^4v}{dx^4} = w(x)$ (the distributed load intensity, taking sign conventions into account). These are the governing equations for beam bending in the small-deflection, linear regime.

- Using $EI\frac{d^2v}{dx^2} = M(x)$, one powerful method to find the deflection $v(x)$ is **integration of the bending moment**. This is often called the double integration method: integrate the moment curve once to get the slope (dv/dx), and integrate again to get the deflection v.

- On the FE exam, you likely won't have to derive the deflection from scratch for complicated cases (standard cases are tabulated – see next subtopic). However, understanding this equation helps in two ways: (1) you might need to apply boundary conditions to a given deflection equation (e.g., knowing that at a fixed support, deflection and slope are zero), and (2) in some simple cases, you could derive a quick formula if you forget it, by integrating. It's also the basis of superposition: since the equation is linear (thanks to that EI factor being constant for prismatic beams), separate load effects add up.

Exam Handbook Search Cues (Not affiliated with or endorsed by NCEES): *deflection equation; $EI\,d^2v/dx^2 = M(x)$; curvature; beam deflection curve; double integration*

Footnotes:

- **Notation:** $v(x)$ (sometimes $\delta(x)$ or $y(x)$ in some texts) represents the deflection of the neutral axis of the beam at position x. Be careful: some sources use y for deflection, but that can confuse with y as vertical coordinate. We'll use v as in the topic outline. The exam reference might use y; just interpret it as deflection in that context.

- **Units:** E (Young's modulus) in Pa (N/m²), I in m^4, so EI has units of N·m². d^2v/dx^2 is curvature (1/m), so $M(x)$ comes out in N·m, consistent. If using US units, E in psi, I in in^4, M in lb·in – the equation still holds with consistent units.

- **Constant EI assumption:** The standard form assumes E and I are constant along the beam (prismatic, homogeneous beam). If a beam has varying cross-section or material (e.g., stepped shaft or composite beam), strictly speaking I or E could change with x, and then you cannot pull EI out of the derivative. The exam problems usually avoid such cases or they'll specify using piecewise integration for each section. For our purposes, assume one EI for the span unless told otherwise.

- **Sign convention:** Usually, the equation is derived with a sign convention: if v is taken as positive downward and M as positive causing concave-up bending (sagging), then $EI\frac{d^2v}{dx^2} = M(x)$ is consistent. If you choose upward deflection as positive, a negative sign might appear ($EIy'' = -M$ for sagging positive M). The exam will typically give you formulas or expect you to just use the magnitudes and intuitive shape. If you stick to the convention given in the handbook, you'll be fine. Just remember to apply boundary conditions accordingly (e.g., at a free end of a cantilever, bending moment is zero, which should reflect in the curvature $v'' = 0$ at that end under the sign convention used).

- **Boundary conditions:** Common boundary conditions for integration: At a **pinned support** (simple support), deflection $v = 0$. At a **roller**, $v = 0$ as well. At a **fixed support**, both $v = 0$ and slope $dv/dx = 0$. At a **free end**, usually bending moment $M = 0$ and shear $V = 0$ (which translate to $v'' = 0$ and $v''' = 0$ at that boundary if using the convention $EIv'' = M$ and $EIv''' = V$). Using these conditions after integration allows solving the constants of integration. Keep these in mind if a problem gives you a formula and asks for something like reaction forces or consistency checks – it ties back to these conditions.

Variations & Related Forms:

- **Deflection Curve Equation:** Starting from $EI\,v'' = M(x)$, integrating once gives $EI\,v'^{(x)} = \int M(x)dx + C_1$. This v' is the slope (rotation angle) of the beam. Integrating again: $EI\,v(x) = \int [\int M(x)dx]dx + C_1x + C_2$. C_1 and C_2 are constants found from boundary conditions. This double integration method is a systematic way to get $v(x)$ if $M(x)$ is known (usually from a moment diagram). In practice, performing these integrals by hand on exam can be time-consuming except for very simple $M(x)$ (like constant or linear). But it's good to conceptually know this approach.

- **Alternate Differential Forms:** As mentioned, $EIv'''' = w(x)$ where $w(x)$ is the distributed load (taking downward as positive w yields a negative on one side depending on convention). Some references also provide a direct integration approach for common $w(x)$ forms (like uniform or triangular loads) which yield $v(x)$ directly. But it's easier to break it into steps: integrate w to get V, integrate to get M, then integrate twice to get v. Each integration adds a constant (or polynomial constant).
- **Use in Superposition:** The linear nature of this differential equation means if you have multiple loads, you can solve for deflection from each load separately (since each load produces a moment function $M_i(x)$, and deflection $v_i(x)$) and then sum all $v_i(x)$ to get total deflection. This is exactly the principle of superposition (next subtopic) applied to the deflection equation. It holds because the equation is linear (no powers of v or anything, just linear derivatives). If the exam asks for combined loading deflection, you can safely superimpose results as long as we're in the elastic regime.

Special Notes (Calculator): The exam-allowed calculators do **not** perform symbolic integration, so you won't be integrating $M(x)$ algebraically on the fly. Instead, rely on known formulas or derive in simplified situations. You *can* use numeric integration features (for definite integrals), but that's rarely needed since deflection formulas are usually given or easily derived by logic/symmetry. If you ever had to integrate a simple polynomial moment diagram, you could do it manually; just be mindful of algebra mistakes. More often, the exam would just give you the deflection formula or ask conceptually about the relationship (like "what's the differential equation relating load, shear, moment, and deflection?").

Explanation & Analysis: Let's capture the Euler–Bernoulli deflection relationship formally:

Equation Passport – Euler–Bernoulli Beam Equation – relates bending moment to curvature (second derivative of deflection) for a beam, foundation of finding deflection curves.

Equation: $EI\,\frac{d^2v}{dx^2} = M(x)$

(Alternate forms by differentiation: $EI\,\frac{d^3v}{dx^3} = V(x)$, and $EI\,\frac{d^4v}{dx^4} = w(x)$, assuming the sign convention that positive w produces downward deflection.)

Variables & Units:

- E – Young's modulus of the material (Pa or psi). Indicates the material's stiffness: higher E means less curvature for a given moment.

- I – second moment of area of beam cross-section (m^4 or in^4). Indicates the section's stiffness: a higher I (stiffer cross-section) means less curvature for a given moment. The product EI is often called the **flexural rigidity** of the beam.

- $v(x)$ – transverse deflection of the beam as a function of position x along its length (m or in). By sign convention here, positive v is downward deflection (assuming loads causing sagging make v positive).

- x – position along the beam (m or ft, etc), measured from a chosen origin (often left end or a support).

- $M(x)$ – internal bending moment as a function of x (N·m or lb·ft). This comes from equilibrium or a bending moment diagram of the loading scenario. It's positive for sagging (tension at bottom) in this convention.

- (Related: $V(x)$ the shear force (N or lb) and $w(x)$ the distributed load (N/m or lb/ft), appearing in higher derivatives as noted.)

Assumptions & Validity:

- **Small Deflections:** The derivation assumes the deflections are small relative to the beam's length (so that geometry changes and higher-order terms can be neglected). This ensures that the relationship between load, moment, and deflection remains linear.

- **Linearity:** Material is linear elastic (no plastic hinge forming, etc.), and the equation itself is linear in v. Because of linearity, superposition applies (we can sum solutions).

- **Plane Sections Remain Plane:** This is behind the fact that curvature $\kappa = d^2v/dx^2$ times I and E gives moment (it comes from integrating strain over the depth). Essentially, it's Euler-Bernoulli theory (no shear deformation considered). For most metal beams, this is fine. If a beam were very deep or made of low shear modulus material, there's a more advanced Timoshenko beam theory (with shear deformation), but that's beyond FE exam scope.

- **Constant EI:** We assume EI is constant along x. If not, the equation would be $d^2v/dx^2 = M(x)/[E(x)I(x)]$, which complicates integration. If an exam problem had two different I segments (say a stepped shaft), you'd just handle each segment separately with its own EI and match boundary conditions at the interface.

Limit Behavior:

- If $M(x) = 0$ over a region, then $d^2v/dx^2 = 0$ in that region, meaning the deflection curve is linear (no curvature) there – essentially, the beam is just straight (no bending) in that span, which makes sense.

- If EI is very large (rigid beam or very stiff material), for a given $M(x)$, the curvature d^2v/dx^2 will be tiny – the beam hardly bends (approaching a rigid rod, which would require infinite EI to have zero curvature under finite moment).

- If $M(x)$ is constant (say in a span with uniform bending moment, like between two equal moments at each end), then v'' is constant, so $v(x)$ is a quadratic function – a uniformly bent shape (part of a circle). For example, a simply supported beam with a pure moment (no shear) would take on a constant curvature shape (circular arc).

Problem-Solving Context: Use this equation to derive deflections when you either:

1. **Know $M(x)$ analytically:** e.g., for a cantilever with an end load, $M(x) = -Px$ (linearly varying along the length). Plug that in and integrate twice.

2. **Need relationships:** e.g., to find where curvature is zero (inflection point) by setting $M(x) = 0$ because $EIv'' = 0$. Or to relate max moment location to curvature peak.
Instead of this, do not confuse it with the **equilibrium equations** ($dV/dx = -w$, $dM/dx = V$) – those are separate but related. Here we are linking to deflection, not directly summing forces.

Common Mistakes:

- **Dropping integration constants:** When integrating $M(x)$ to get slope and deflection, you must include constants of integration (two of them by the time you integrate twice). Use boundary conditions (supports conditions) to solve for them. It's a common error to forget that say at $x = 0$, deflection might be zero (fixed or simply supported) which lets you find one constant, etc. Always apply the physical constraints after integrating.

- **Misapplying sign conventions:** If you mix up whether v is taken as positive upward or downward, you might introduce a sign error. A practical way to avoid confusion: you know physically how the deflected shape should look – if you get a negative deflection where you expected positive (downwards), it might be just that your coordinate sign is opposite. What matters is relative values and shape. In calculation, stay consistent with the formula as given in the handbook. For instance, the handbook likely gives $EId^2v/dx^2 = M$ explicitly – stick to that and you won't need to second-guess signs.

- **Time management:** While not a "mistake" in theory, on the exam it's a mistake to try to derive a complex deflection from scratch via integration if a formula can be looked up or remembered. Know the standard cases (next section) or how to quickly find them. The integration method is your tool of last resort if you blank on a formula or if the problem gives a non-standard load but simple enough to integrate. Even then, set up the $M(x)$ piecewise if needed, integrate systematically, and use conditions – but watch the clock.

- **Forgetting the relationship to loading:** Sometimes, exam problems test the conceptual understanding of these derivatives. For example: given a deflection curve equation, they might ask where the bending moment is zero – you'd set $v'' = 0$ (since $EIv'' = M$) to find inflection points. Or given a loading diagram, they might ask "which of these is the correct deflected shape" – you should recall that where M is zero, curvature is zero (inflection), where M is max, curvature is max, etc. Not a numerical mistake, but an interpretative one: remember the qualitative links (moment diagram shape vs deflection curve shape).

In summary, the Euler–Bernoulli beam equation is the backbone of beam deflection analysis. For FE exam purposes, you should be aware that **deflection is obtained by integrating moment (twice)** and that **the equation $EIv'' = M(x)$ appears in the reference handbook** – a clue that if asked, you can write it down or use it to eliminate wrong answer choices. It's also a reminder that if you ever feel stuck, you can always derive what you need: e.g., derive a cantilever tip deflection by integrating $M(x)$ rather than trying to memorize everything. But with the next subtopic, we'll arm you with the standard deflection formulas so that integration is usually unnecessary under exam pressure.

K08.T04.S04 – Use of Standard Beam Deflection Formulas and Tables for Common Loading Cases

Principle Introduction:

- Solving beam deflections via integration for every new problem would be far too time-consuming, especially in an exam setting. Thankfully, for many **common loading cases and support conditions**, the deflection and slope results have been derived and tabulated. As an examinee, you're expected to use these **standard beam deflection formulas** rather than re-derive them. Knowing these standard cases (or at least knowing how to quickly find them in the exam handbook or your notes) is a huge time-saver.

- Typical cases include: **cantilever beams** (with concentrated load at the free end, with uniformly distributed load, etc.), **simply supported beams** (with a center load, with a uniformly distributed load, with an arbitrary point load), and others like a beam with an overhang or a fixed-end beam. Your exam reference manual typically includes a selection of these formulas (usually deflection and slope for a few cases, plus perhaps fixed-end moments for certain cases).

- The approach on exam day is usually: identify which standard case matches the problem (or a combination of cases), then plug in the given values into the known formula. For example, if a problem says "A simply supported beam of length L has a uniform load w (N/m). What is the deflection at mid-span?", you should recognize this as a standard case and recall or look up $\delta_{\max} = \frac{5wL^4}{384EI}$.

- Using these tables correctly requires careful attention to the scenario details: support type (simple, fixed, cantilever), load type (point load, distributed, location of load), and what exactly the formula gives (maximum deflection, deflection at a specific point, slope at a support, etc.). It's easy to misapply a formula if you pick the wrong case or misidentify L vs segment lengths, so read the problem sketch closely.

- Another benefit: **superposition** (next topic) can extend these standard solutions. If you have a non-standard load, you can often treat it as a combination of standard ones. For instance, a beam with two separate point loads can be solved by adding the deflections from each point load case (one at a time). Or a triangular load can be broken into an equivalent combination of uniform load + some other distribution if needed (though typically beyond what FE will require).

Exam Handbook Search Cues (Not affiliated with or endorsed by NCEES): *beam deflection table; simply supported deflection; cantilever deflection; maximum deflection; slope formula* (The handbook contains a section with beam formulas – you can find them via keywords like "deflection" or by scanning the Mechanics of Materials section index.)

Footnotes:

- **Units consistency:** The formulas assume a consistent unit set. If you plug values in SI units (N, m, Pa, m^4), deflection comes out in meters. In US units (lb, ft or in, psi, in^4), deflection comes out in the length unit used (ft or in). Make sure L is in the same unit as used in I (if I is in in^4, use L in inches for these formulas or convert I to ft^4 if using L in ft, etc.). The E value should correspond (psi with inches, or Pa with meters). It's straightforward but a common place to slip.

- **Interpreting formula outputs:** Many tables give the **maximum deflection** in terms of L. For example, "Simply supported beam, uniform load: $\delta_{\max} = 5wL^4/(384EI)$ (at mid-span)." This means at $x = L/2$, the deflection is that value and it's the largest. If the problem asks for deflection at some other point, you need the general equation $v(x)$, which the tables often also provide (sometimes in a piecewise form if the load isn't symmetric). The handbook might show the equation $v(x)$ for the entire span or just the max. If only the max is given and you need at another point, either derive by symmetry or superposition, or better, use the shape equations if provided. Usually, FE questions stick to asking for **max deflection or deflection under a load** – something directly from common cases.

- **Fixed-end beams:** A beam fixed at both ends with loads is statically indeterminate (the reactions depend on deflection compatibility). The tables include fixed-fixed cases (like uniform load on a fixed-fixed beam) which have smaller deflections (because the fixity provides extra restraint) and moment reactions at the supports. If an exam question involves a fixed-fixed scenario, you'd definitely rely on the provided formula (derivation involves solving for reaction moments using boundary conditions). Support fixity changes only the coefficient, not the form. For a full-span uniform load: simply supported gives $5wL^4/(384EI)$ at midspan, while fixed–fixed gives $wL^4/(384EI)$ at midspan (five times smaller).

The key point: more restraint = less deflection.

- **Slope formulas:** Tables also often list the slope (rotation angle in radians) at key points (like at supports or at free end of a cantilever). A question might ask for the angle of deflection at the end of a cantilever. For example, cantilever with end load: slope at the fixed end is zero, slope at the free end is $\theta = \frac{PL^2}{2EI}$ (downward rotation in radians). If needed, these can be used, but deflection is more commonly asked. Still, remember slope is just first derivative of deflection, so its formula often has a similar form but one power of L less.

- **Exam strategy:** You are **not expected to memorize all these formulas** (though having a few common ones in memory speeds you up). The exam's reference will have them, and being quick at searching by keywords like "cantilever" or "beam simply supported" will help. Practice using the electronic PDF search (or physical index) ahead of time. Also, try to memorize the general "shape" of the solution: e.g., deflection is proportional to $wL^4/(EI)$ or $PL^3/(EI)$ times some numeric factor. That way if you ever forget the exact coefficient, you can at least eliminate wrong answers that are off by orders of magnitude or clearly unreasonable. For instance, if you get a deflection of 10 meters for a beam that's 2 m long, you know something's wrong.

Table Passport – Common Beam Deflection Formulas: The following table compiles several **standard beam deflection results** that are frequently useful. These are given for ideal conditions (small deflection, linear behavior). All deflections v are measured *from the original (undeflected) straight position*, with downward deflection taken as positive in these formulas.

Common Beam Deflections for Standard Cases (max deflections unless noted):

Beam Scenario & Loading (Diagram)	Deflection v (at specified location)
Cantilever, end point load P at free end (Fixed at left end $x = 0$, load P downward at $x = L$)	**Deflection:** $v(L) = \frac{PL^3}{3EI}$ (downward at free end) **Slope:** $\theta(L) = \frac{PL^2}{2EI}$
Cantilever, uniform load w (force/length) over entire length (Fixed at $x = 0$, load distributed to $x = L$)	**Deflection:** $v(L) = \frac{wL^4}{8EI}$ (max at free end) **Slope:** $\theta(L) = \frac{wL^3}{6EI}$
Simply Supported, single point load P at mid-span (Pin at $x = 0$, roller at $x = L$, load P at $x = L/2$)	**Deflection:** $v(L/2) = \frac{PL^3}{48EI}$ (max at mid-span)

Simply Supported, uniform load w over entire span (Pin at 0, roller at L, load w from 0 to L)	**Deflection:** $v(L/2) = \frac{5wL^4}{384EI}$ (max at mid-span)
Fixed–Fixed (both ends fixed), uniform load w over span (Fixed supports at 0 and L)	**Max deflection (at center):** $v_{\max} = \frac{wL^4}{384EI}$ *Note: this is 1/5 of the simply supported uniform-load case.*

In each scenario, the beam is horizontal initially. For cantilevers, left end is fixed. For simply supported, ends are supported without moment. Arrows indicate loads. Deflection shapes are exaggerated for clarity.

How to Read & Use: Identify the row that matches your beam's support and load configuration. Plug in the values for P or w, L, E, and I into the given formula. The result is the deflection at the location specified (often the worst-case location). If you need the deflection at some other point or the slope, see if it's provided (some rows list slope or general $v(x)$ equations in full references). On the exam, if the problem exactly matches one of these cases, you can directly calculate the answer with these formulas. If the load is not exactly centered or different, you might need the more general form or to use superposition.

Units: Ensure consistency. These formulas are derived symbolically assuming a coherent unit system. For example, if P is in kN and L in m, use E in Pa and I in m^4 to get v in meters. If you mix units (say P in lb, L in ft, E in psi, I in in^4), convert everything to one system before calculating or carefully convert the final answer. These deflections tend to be small in realistic terms (e.g., fractions of an inch or a few millimeters), so if you get an answer like 2 meters of deflection for a 5-meter beam, double-check your units or formula.

Source Note: The formulas listed here are classical Euler–Bernoulli beam results found across many Strength of Materials / Mechanics of Materials textbooks. The layout, wording, and examples in this handout are independently written for quick review.

Typical Exam Uses:

- *Finding Max Deflection:* Given P, w, etc., and beam specs, compute $\delta_{\max}$ to see if it exceeds a limit or just to answer a direct question "what is the deflection at mid-span."

- *Back-calculating Load or Dimension:* If a problem states "the beam deflects X amount under Y load, what is I (or what is w)?", you can rearrange the appropriate formula to solve for the unknown. For instance, plug known deflection and solve for I.

- *Comparing Stiffness:* Qualitative questions might ask "which beam deflects more" given two scenarios – you can compare forms. E.g., a cantilever vs simply supported under same load – plugging numbers or just knowing the relative factor (cantilever end load deflects more).

Common Pitfalls:

- **Choosing the wrong case:** The biggest mistake is picking a formula from the table that doesn't match the problem. Pay attention to whether the beam is cantilevered or simply supported or fixed. Also note if the load is centered or distributed. A classic error is to use the simply-supported formula for a cantilever problem or vice versa. The results differ by a factor (cantilever deflections are larger). If unsure, derive quickly for sanity: e.g., a cantilever with end load should deflect more than a simply supported with mid load of the same magnitude because the cantilever is less supported – indeed $\frac{PL^3}{3EI}$ is bigger than $\frac{PL^3}{48EI}$ by a factor of 16!

- **Forgetting internal spans:** If a problem gives, say, a beam with an overhang or multiple spans, none of the single-span formulas directly apply. Don't try to jam such a case into a simple formula. Instead, break the beam into parts or use superposition. For instance, an overhang can be seen as a simply supported span plus a cantilever part – combine effects. The exam likely won't throw a multi-span indeterminate beam without guidance, but be alert.

- **Sign error for deflection direction:** All these formulas give the magnitude of deflection (downward). If you define upward as positive in your equation, you might get a negative number from plugging in (because the deflection is downward). Don't let a negative sign confuse you – interpret it: a negative result would just mean the deflection is downwards given your coordinate. The exam generally asks for magnitude or uses "downward deflection" wording.

- **Misusing superposition:** When combining cases, ensure the deflection pattern is the same. For example, to find deflection under two separate point loads on a simply supported beam, compute deflection from each load individually at the point of interest, then add. But if the point of interest is not under one of the loads, you must still account for each load's influence there. Use the general formula or influence lines if you know them (though influence lines might be beyond FE scope). A safer route: use the table formula for a point load at a general position a from left support (some references give $v(x)$ for that) or use symmetry if loads are symmetric.

- **Calculator use:** Entering these formulas into your calculator can be error-prone. Use parentheses liberally. For example, $\frac{5wL^4}{384EI}$ might be entered as 5 * w * L^4 / (384 * E * I). A common mistake is to miss parentheses and end up dividing by 384 and then multiplying by EI erroneously. Also, watch out for overflow if L^4 is large and your calculator, ensure to do the multiplications in a safe order (most can handle it, but just in case, you can divide earlier). If w or P is zero, obviously deflection is zero – sometimes plugging zero in a formula can inadvertently test if you understand that trivial case.

Application Example: Suppose a question asks: *"A 3 m long cantilever beam (fixed at one end) carries a 10 kN point load at its free end. If $E = 200$ GPa and $I = 4 \times 10^{-6}\ m^4$, what is the*

deflection at the free end?" This is a direct use of the first row: $\delta = PL^3/(3EI)$. Plugging in: $P = 10000$ N, $L = 3$ m, so $PL^3 = 10000 * 27 = 270000$ N·m^3. $3EI = 3 * (200 \times 10^9\text{Pa}) * (4 \times 10^{-6}\text{m}^4) = 3 * 200 * 4 \times 10^3\text{N·m}^2 = 2400 \times 10^3\text{N·m}^2$. Actually compute: $3EI = 3 * 200e9 * 4e - 6 = 3 * 800e3 = 2400e3$ N·m² = 2.4×10^6 N·m². Now $\delta = 270000/2.4e6 = 0.1125$ m (approximately). That's 112.5 mm downward. Such a deflection for a 3 m beam under ~1-ton load might be plausible depending on cross-section. If you accidentally used simply-supported formula $\frac{PL^3}{48EI}$, you'd get much smaller deflection (7 mm) which wouldn't match a cantilever reality – a clue you picked wrong. Always double-check: cantilever deflects more.

In conclusion, using standard deflection formulas is about pattern recognition and careful substitution. Practice identifying beam types from word problems or diagrams, and remember you have resources to get the exact equations. It's more about knowing *what formula to apply* than memorizing every detail. When in doubt, apply fundamental principles (previous subtopic) to derive or verify a result.

K08.T04.S05 – Superposition Principle for Beam Deflections

Principle Introduction:

- The **Principle of Superposition** is a powerful concept that applies to linear systems, including the elastic behavior of beams. In simple terms for beams: *When a structure is subjected to several loads, the deflection (or internal force or stress) at any point equals the sum of the contributions from each load applied separately, as long as the required conditions are satisfied*.

- In the context of beam deflections, this means if you have several loads (point loads, distributed loads, moments, etc.) acting on a beam, you can compute the deflection due to each load separately (using formulas or integration) and then add them up to get the total deflection. This greatly simplifies analysis when no single formula covers the combined loading.

- The conditions for superposition to be valid are essentially the linearity conditions we've mentioned: (1) the response scales in direct proportion to the applied load (which is true as long as we're using $EI\,v'' = M$ and not yielding the material), and (2) the deflections are small enough that the structure's geometry/load path is essentially unchanged (small deflections so geometry isn't changed). These are usually satisfied in typical FE exam problems (no plastic deformation, no huge deflection geometry changes).

- Practically, superposition is used in exam problems like: a beam with two-point loads at different locations (deflection = sum of deflection from each point load alone), or a combination of a uniform load and a point load (deflection = deflection from uniform + deflection from point). It's also used if you need a result that isn't directly in tables: e.g., deflection at a quarter point under a uniform load – you might get that by superposing two simpler load cases or using half-length symmetry. In structural analysis, superposition is everyday practice; for the FE, just remember you *can* and *should* use it for linear scenarios.

- Another area: superposition applies to **stresses** and internal forces too. For example, if a beam has both bending from a vertical load and bending from an end moment, the total bending stress at a fiber = stress from load + stress from moment, etc. However, be careful to only superimpose the same type of effect (add deflections to deflections, moments to moments, etc., not apples to oranges).

Exam Handbook Search Cues (Not affiliated with or endorsed by NCEES): *superposition; combined loads; linearity; beam multiple loads* (Searching "superposition" in the handbook leads to a statement of this principle under Mechanics of Materials.)

- **Linear vs Nonlinear:** Superposition fails if the system behaves non-linearly. Examples of non-linear behavior: material yielding (stress no longer proportional to strain), very large deflections (geometry changes making $M = EIv''$ invalid), or if load–response relation isn't straight line (like some cables or plastic hinges). On the FE, you'll likely assume linear elastic always (unless a plastic analysis question clearly says otherwise). So superposition will usually be valid.

- **Support conditions:** When using superposition, each sub-case analysis should respect the original boundary/support conditions. For instance, if you're analyzing a beam with two loads by splitting them, each sub-problem uses the same supports (you don't, say, remove a support). This sounds obvious, but a subtle point: if a beam is statically indeterminate (like fixed-fixed), splitting loads still must maintain the fixed end conditions in each sub-case. The standard superposition approach works for deflections and internal forces, but solving indeterminate beams via superposition often means including unknown redundant forces as "loads" to be determined (beyond FE scope, except simple cases). For exam purposes, they won't make you solve a truly indeterminate beam from scratch – they might give you the formula or ask conceptually.

- **Signs and directions:** When adding deflections or forces, consider their direction. If one load causes an upward deflection at a point and another causes downward, the net deflection is the algebraic sum (which could be smaller if they partially counteract). Most of the time all loads act in the same general direction (e.g., gravity loads all cause downward deflection), so you just add magnitudes. But imagine: one load might cause a beam to curve up at one end while another load causes a curve down at that same point – if so, you'd subtract one effect from the other. This usually comes into play in weird cases (like an upward reaction force acting like a support lift). Just be mindful: **superposition is algebraic** (with sign).

- **Combining different response types:** You can also superimpose different result types if needed. For example, total stress = stress from bending + stress from axial + stress from thermal (if all are within elastic range). But you cannot directly add, say, deflection and rotation – they are different quantities. That sounds silly, but the point is: apply superposition within the same response measure. For beams, typically it's adding deflections to deflections, or adding bending moments distributions from separate loads to get total bending moment distribution (which is standard when drawing combined shear/moment diagrams).

Definition Passport – Principle of Superposition:

Plain-language definition: The principle of superposition says that for a linear system, the combined effect of multiple loads is just the sum of the effects of each load acting alone. In other words, **you can solve one load at a time and add the results** for deflections, stresses, etc., as long as everything stays within the linear elastic range.
Where it matters (exam impact): This concept is used in many beam problems. For the FE exam, you might encounter it when dealing with multiple loads on a beam or shaft. Instead of trying to handle a complicated loading in one go, you break it down: find deflection due to Load 1, find deflection due to Load 2, then add. It shows up whenever you use provided formulas for simple cases and add them

together to get a solution for a complex case. Also, in superposition of stresses: e.g., a combined loading problem might have bending + axial – you'd find each stress and add them (with attention to sign/tension or compression).

Pitfall or confusion point: A common misunderstanding is to use superposition when it doesn't apply – like adding effects when the material has yielded (not linear anymore) or when interactions matter. Another is forgetting to apply the same reference for deflections (make sure the deflections you add are in the same direction coordinates). Some students also forget that superposition can be used and try to solve a multi-load problem in one complicated step, which is error-prone and time-consuming.

Micro-check: *True/False:* "If Load A causes 2 mm deflection at a point and Load B causes 3 mm deflection at the same point (each acting separately), then with both loads acting together (in the linear range) the deflection at that point will be 5 mm." – **True.** (Superposition holds, so 2 + 3 = 5 mm total downward deflection in this case.)

Explanation & Analysis: To utilize superposition effectively, follow a structured approach:

1. **Decompose the Loading:** Identify each distinct load (or load pattern) acting on the beam. For example, you might have a point load at a certain location, plus a uniform distributed load, plus maybe an applied moment at the end. Treat each of these as separate cases. It can help to sketch the beam for each load alone, with all other loads removed. Keep the support conditions the same as the original problem for each sketch. (I often label these cases as Case 1, Case 2, etc.)

2. **Find the Effect of Each Load:** For each load case, determine the quantity of interest (deflection, slope, stress, etc.) at the point or region of interest. Use the appropriate formula or method for that single load. For instance, use the table from the previous subtopic to get deflection due to the point load, then use it again (or another formula) to get deflection due to the uniform load. You might end up with expressions or numeric values for each case.

3. **Add the Effects:** Algebraically add the contributions from each load to get the total. If all contributions cause deflection in the same direction (e.g., downward), you add them arithmetically. If one might cause an upward deflection relative to your coordinate, be sure to add it as a negative. Usually, exam problems are set up so things add nicely. For stresses, be mindful of tension vs compression (you might assign one positive and one negative and add accordingly to see net stress).

4. **Apply any Combined Conditions:** Sometimes, combined loads can introduce conditions like a midpoint slope being zero or something if symmetric – but that usually simplifies rather than complicates. Just ensure the final combined result satisfies the overall boundary conditions. (If you used known formulas for each separate case that individually satisfy the boundary conditions except at points of load application, the superposition will satisfy all equilibrium and compatibility automatically because it's linear.)

5. **Check Results for Reasonableness:** After adding, give it a sanity check. Does the deflection seem plausible relative to each component? For example, if one load gave 2 mm and another gave 3 mm, expecting ~5 mm total is logical. If you got 50 mm, you likely erred in arithmetic. Also check extreme scenarios: if one load magnitude was zero, does your combined result reduce to just the effect of the other load? It should. This is a quick partial check of correctness.

Common Mistakes & Clarifications:

- One tricky aspect could be **superposition in indeterminate situations**: For example, a fixed-end beam under a load might be solved by superposition by combining a simply-supported deflection plus whatever to enforce zero slope at the ends (method of superposition with a redundant moment). The FE exam tends not to have you do that from scratch, but if it did, they'd likely give guidance or partial results. The principle still holds; you just may have an unknown reaction that you satisfy by adding an appropriate counter-load (this is essentially how you solve indeterminate beams with superposition, by adding a fictitious load like an unknown moment then solving for it via deflection compatibility). This is advanced, so again, typical FE questions stick to straightforward superposition of known cases.

- Remember that **superposition is not just for deflections**. It's equally valid for internal forces: e.g., drawing a moment diagram for combined loads can be done by drawing moment diagram for Load1 and Load2 separately and then adding those diagrams pointwise. Same for shear diagrams. You might get a qualitative question asking about bending moment superposition (like adding influence of loads on bending moment at a certain section). The concept is identical.

- Another note: **Thermal expansion and support settlement** can also be thrown into superposition. If a support moves downward by some Δ (settlement) and there's also a load, you can analyze the deflection from load and the deflection from enforced support movement separately and add. Thermal effects (if linear within elastic range) can be treated like an equivalent load case as well. So keep an open mind – superposition is a general linear principle, not tied only to mechanical loads. On the exam, if they mix a support settlement with a load, think: deflection due to settlement (which might be just that Δ at that end plus how it propagates as slope, etc.) plus deflection due to the loads.

- **Real-world note (to build intuition):** Superposition is why structural engineers can have influence tables or why you can analyze complicated loads by breaking them into simpler ones. It's like "overlaying" effects. If you've ever done the trick of stacking transparencies with graphs, that's an analogy – each transparency is a deflection curve from one load, stacking them (adding vertically) gives the final curve for all loads. If one transparency had a curve going up while others go down, the result is some mix. Because everything is linear, there's no weird surprises – just arithmetic addition.

Quick example to cement it: Imagine a simply supported beam with a 5 kN point load at mid-span and a 2 kN/m uniform load. You're asked for the deflection at mid-span. Approach: Case 1 – 5 kN at mid (no uniform load). Case 2 – 2 kN/m uniform (no point load). Use formulas: Case 1 gives $v_1(L/2) = PL^3/(48EI)$, Case 2 gives $v_2(L/2) = 5wL^4/(384EI)$. Add them: $v_{\text{total}}(L/2) = \frac{PL^3}{48EI} + \frac{5wL^4}{384EI}$. Combine into common denominator if needed: $= \frac{8PL^3+5wL^4}{384EI}$ (with appropriate units). That's your answer (you could numeric

plug too). Each part came from a standard case; together they solve the combined case.

Finally, be confident in using superposition: it's often the **intended solution path** for multi-load problems on the FE exam. It saves time and reduces errors compared to doing complicated integrations or derivations for combined loads. As long as you remember it's valid in elastic, linear scenarios (which basically all FE problems are unless stated), you can apply it freely. It's one of those fundamental techniques that not only help in exams but in real engineering analysis whenever linear assumptions hold.

Topic 05 - Stress and Strain from Torsional Loads

Topic Introduction: Torsional loads twist structural and machine elements, producing **shear stress** and **shear strain** in those components. On the **FE Mechanical Exam**, you'll encounter problems where a shaft or rod carries a torque and you must determine either the resulting shear stress or the angle of twist. These questions often involve straightforward formula application – given a circular shaft's dimensions and an applied torque, **find the shear stress at the outer surface**, or **calculate how many degrees the shaft twists** over its length. Mastering this topic means you can quickly recognize which torsion formula to use and avoid confusing torsion with bending or axial formulas under exam pressure. The key is remembering that **for circular shafts, torque causes a shearing distortion** (imagine twisting a screwdriver) – and the formulas in this chapter give you the stress at any radius, the twist angle, and the strain distribution. Let's break down the essential "passport" items for torsional stress and strain.

K08.T05.S01 – Torsional Shear Stress in Circular Shafts

Principle Introduction: *When a circular shaft is subjected to a torque, shear stresses develop internally across any cross-section.* These stresses vary linearly with the distance from the center of the shaft. Key points to remember include:

- **Circular Cross-Section Requirement:** The simple torsion formula applies to circular (solid or hollow) shafts. Other shapes (square, rectangle) have more complex, non-uniform stress states (beyond FE scope).
- **Linear Variation:** Shear stress is zero at the center and increases linearly towards the outer radius. The maximum shear stress occurs at the surface.
- **Polar Moment of Inertia (J):** The resistance of a cross-section to twisting is quantified by J. A larger J (which comes from a larger or hollow cross-section) means lower stress for the same torque.
- **Max Stress at Outer Fiber:** Often, exam questions ask for the *maximum torsional shear stress* – which you get by plugging the outer radius into the formula. This represents the worst-case stress in the shaft material under that torque.
- **Solid vs. Hollow:** For a hollow shaft (thick-walled tube), the same formula applies at any given radius; you typically use the outer radius for max stress or the inner radius if needed. The value of J differs for solid vs. hollow sections, but the linear stress distribution assumption holds as long as the wall isn't extremely thin (see Subtopic S03 for thin-wall case).

Exam Handbook Search Cues (Not affiliated with or endorsed by NCEES): *torsion stress*, *polar moment*, *circular shaft*, *shear stress* τ, *torque (T)*

Equation Passport: *Torsional Shear Stress Formula – computes the internal shear stress at any radius in a circular shaft under an applied torque.*

Name and purpose: Torsion Formula – Determines the shear stress τ at a radial distance r from the center of a circular shaft due to an applied torque T. It's used to find stress in solid or thick-walled circular shafts under twist.

Professional equation: $\tau(r) = \frac{T\,r}{J}$, for $0 \le r \le c$ (valid anywhere within the cross-section, reaching maximum at $r = c$, the outer radius). Often used in the outer-fiber form: $\tau_{\max} = \frac{T\,c}{J}$, where c is the shaft's outer radius.

Variables and units:

- T – Torque (twisting moment) applied to the shaft, *in units like N·m or lbf·ft*.
- r – Radial position within the cross-section where stress is evaluated, *in m (SI) or in (USCS)*.
- c – Outer radius of the shaft (m or in). (For a solid shaft, c is the actual radius; for a hollow shaft, c is outer radius, and inner radius is a smaller value.)
- J – Polar moment of inertia of the cross-section about its center (units: m^4 in SI, in^4 in USCS). J **represents the shaft's stiffness against torsion.** For a solid circular shaft of radius c, $J = \frac{\pi c^4}{2}$. For a hollow circular shaft with outer radius $r_o = c$ and inner radius r_i, $J = \frac{\pi}{2}!\left(c^4 - r_i^4\right)$. *(These formulas aren't explicitly in the exam reference, but you're expected to know common J values.)*
- τ – Shear stress at the point located a distance r from center (units: $Pa = N/m^2$ in SI, or psi in USCS). On the exam, $\tau_{\max}$ is typically what they want (at $r = c$).

Assumptions and scope:

- *Circular shaft, linear elastic material:* Formula assumes the cross-section is circular (so it doesn't warp under torsion) and that the material obeys Hooke's law (stress proportional to strain) up to the stresses in question. No yielding or plastic deformation (which would change the stress distribution) – this is within elastic range.
- *Uniform cross-section:* The shaft has a constant cross-section along its length and the torque is applied smoothly (no stress concentrations or keyways considered in this basic formula).
- *No dynamic/transient effects:* This is a static or steady-state formula (applies after any shock or transient has settled, and assuming load is applied slowly enough to avoid dynamic effects).
- *Thick-walled means still using J:* "Thick-walled" generally means the wall thickness is not negligible (thickness > 0.1× radius). We still use this formula for thick-walled tubes by using the exact J. (For extremely thin walls, see S03.)

Limit tests (sanity checks):

- If $T \to 0$, then $\tau(r) \to 0$ everywhere – no torque, no stress (makes sense).

- If $r = 0$ (center of the shaft), $\tau(0) = 0$ – the core experiences no shear stress, as expected.
- If we double the torque T, the stress at every point doubles (linear relationship). So, watch units: a small mix-up (like using N·mm instead of N·m) would drastically scale τ – always check that T and J use consistent units.
- If you compute $\tau_{\max} = \frac{Tc}{J}$ at the outer surface, and then imagine the radius c growing larger while keeping T the same, $\tau_{\max}$ actually increases (because J grows with c^4, but c grows linearly – net effect, a larger diameter shaft dramatically reduces stress). This passes the sniff test: a thicker shaft handles the same torque with less stress.

Use vs. sibling equations: Use *this torsion formula* instead of bending or axial formulas when you have a **twisting load** (torque) on a circular shaft. It differs from the bending stress formula ($\sigma = My/I$) by involving the polar inertia J and radius r instead of I and neutral axis distance y. Do **not** confuse J (polar moment for torsion) with I (area moment for bending) – they are different properties. If the problem involves **transverse shear** (like a beam with shear force V), you would use $\tau = VQ/(Ib)$ instead, but for a pure torque on a round shaft, $\tau = Tr/J$ is the go-to equation. If using FE Handbook convention with y positive upward, use σ = −My/I.

Common exam traps:

- *Using the diameter instead of radius:* The formula uses radius r. If a problem gives you diameter D, remember to use $r = D/2$ in the calculation. A common mistake is to inadvertently use D in place of r, which overestimates stress by a factor of 2.
- *Mixing up J and I:* Polar moment J for a circle is different from the planar second moment I. For a solid circle, $I = \pi c^4/4$ about a centroidal axis (like for bending about a diameter), whereas $J = \pi c^4/2$ about the center (for torsion). Ensure you're using the polar moment for torsion problems. The exam reference lists J under torsion formulas, not in the bending section.
- *Unit consistency:* If you input torque T in N·m and J in mm^4 (a common scenario if dimensions are given in mm), your stress comes out in mixed units. Convert J to m^4 or T to N·mm accordingly. Likewise, if working in USCS, use lbf·in with in^4, or lbf·ft with ft^4 – don't mix inches and feet in one formula.
- *Hollow shaft inner radius usage:* If asked for stress at the inner surface of a hollow shaft, don't plug $r = 0$ (that's the center, not inside surface). Use $r = r_i$ for inner wall stress. It will be lower than at the outer wall – hollow shafts concentrate stress at the outer boundary.

Footnotes: *Units and conventions* – Shear stress τ is typically given in Pascals (Pa) or psi. On the exam, you might see MPa or ksi for convenience (since stresses often are large numbers). Remember that 1 MPa = 10^6 Pa, and 1 ksi = 1000 psi. *Symbol nuance* – The symbol J for polar moment is standard in torsion. Don't confuse it with J as a polar mass moment of inertia (sometimes used in dynamics), though context usually clarifies this (in dynamics J might denote mass moment, but in mechanics of materials, J is area-based polar inertia). *Scope consideration* – The formula $\tau = Tr/J$ holds as long as the material remains elastic. If a question hinted at plastic torsion or something (unlikely for FE), the distribution would change; however, FE exam questions stick to elastic behavior.

Variations and related forms: One useful related concept is **torsional stress concentration** – not covered by this formula, but if a shaft has a notch or keyway, the stress is higher locally. The exam **typically avoids stress concentrations** unless a factor is given. Also, note that for **non-circular shafts** (like a rectangular bar under torsion), this simple formula doesn't apply; those cases involve non-uniform stress (and warping) and require advanced formulas (beyond FE scope, so you wouldn't be expected to handle that without being given an equation). **Typical values:** For steel shafts, a typical allowable shear stress might be on the order of tens of MPa (say 50–100 MPa) in design scenarios. But exam problems will give you the necessary info; you won't need to recall specific material limits, just apply the formula. **Hollow vs. Solid:** A hollow shaft can often carry the same torque as a solid one with less weight – because removing the inner core (where stress is low) doesn't significantly reduce J but cuts a lot of material. This might come up conceptually, but if a question expects a comparison, just compute $\tau_{\max}$ for both and see which is lower.

Special notes (calculator usage): Entering this formula in the allowed exam calculators (Casio fx-115/991, HP 35s, TI-36X, etc.) is straightforward – it's basic arithmetic. Just be cautious to compute J carefully. For example, if you have to compute $J = \pi c^4/2$, you might do it in steps: first compute c^4, multiply by π, then divide by 2. There's no dedicated "torsion" function, so it's all manual. If dealing in scientific notation (e.g., J might be a very small number in m^4), use the calculator's E notation properly. Also, if the result for τ is extremely large or small, check that you input units consistently – the calculator won't know if you mixed mm and m, but an odd result (like an enormous Pa value) is a clue to re-check unit conversions.

Explanation (in plain language): This torsional shear stress formula is used whenever you need to find how much stress a twisting action causes inside a round shaft. *Where it applies:* think of things like drive shafts, bolts, or any cylindrical mechanical component being torqued. On the FE exam, a typical problem might give you a solid rod of given diameter and a torque, and ask for the shear stress – you'd use $\tau = Tc/J$ to get the stress at the surface. Another problem might involve a hollow tube (like a pipe) under torque and ask which experiences more stress, the solid or hollow, given same outer diameter; using the formula with appropriate J for each answers that. The basic idea is that twisting tries to shear the material: the interior resists less (like the core of a potato being twisted barely moves, while the skin sees the most twist). So this formula quantifies that: stress grows with radius.

Analysis (term by term breakdown): Take $\tau(r) = \frac{Tr}{J}$ step by step: - T (Torque) is the cause – how hard you're twisting. Doubling T doubles every τ value, directly. - r/J is the geometric factor. J (polar moment) is like a "spreader" of torque: a big J (fatter or hollow shaft) spreads out the torque's effect, lowering stress. r is where you measure – farther out means higher stress. Combine them, r/J basically says *what fraction of the torque's effect is felt at radius* r. At $r = c$, that fraction is c/J, giving max stress. - Units check: Say T in N·m and J in m^4, then T/J has units $N \cdot m/m^4 = N/m^3$. Multiply by r (m) gives N/m^2, i.e. Pascals – good, that's a stress unit. In USCS, T in lbf·in and J in in^4 gives $lbf \cdot in/in^4 = lbf/in^3$, times inches gives lbf/in^2 (psi), also consistent. - Physical meaning of each symbol: - T: how much twisting moment is applied. Imagine wrenching on the shaft – T quantifies that twist effort. - J: how the cross-section's area is distributed around the center. More area far out (high r) yields a

large J, meaning the shaft is very resistant to twist (like a pipe vs a solid rod of same mass – the pipe has more material farther out, larger J). - r: the specific location in the material we care about. Near the center (r small), the material isn't shearing much. Near the outside (r large), it's shearing a lot more (covering a bigger arc length for the same twist angle). - τ: the resulting shear stress, basically force per area internally trying to resist the twist. - *Common pitfalls in calculation:* forgetting to square the radius in J calculations (e.g., using $\pi d^4/32$ incorrectly or arithmetic slips), dropping units (especially π often gets approximated – don't round too early). Also, if the problem gives torque in, say, lb·ft but dimensions in inches, convert one of them (preferably convert torque to lb·in to use J in in^4). - *Sign convention:* Torsional shear stress doesn't usually need a "sign" (we often just care about magnitude), but if you needed direction, by right-hand rule the shear direction reverses on opposite sides of the cross-section. This is beyond what FE expects; just remember shear stress will have two directions on perpendicular faces (one clockwise, one counterclockwise), but the formula gives magnitude. - If you ever get a negative value plugging numbers in, something's wrong – either a sign mistake or input error, since T, r, J are positive scalars in these problems (direction is handled separately if needed).

K08.T05.S02 – Angle of Twist in Shafts

Principle Introduction: *Twisting a shaft not only induces stress, it also causes the shaft to rotate slightly along its length.* The angle of twist tells you how far one end of the shaft turns relative to the other under a given torque. Important points for this subtopic:

- **Linear Elastic Twist:** For uniform shafts, the twist angle is proportional to the applied torque (double the torque → double the twist) and proportional to length (double the shaft length → double the twist, like a longer spring twisting more for the same torque).
- **Stiffness (GJ/L):** The term GJ/L is the torsional stiffness of the shaft. A high shear modulus G (rigid material) or a large polar moment J (thick cross-section) makes a shaft harder to twist (small angle for a given T). A longer shaft (large L) is easier to twist (think of a longer rod being more flexible in torsion).
- **Units (Radians!):** The formula naturally gives the twist angle θ in **radians**. It's easy to forget to convert to degrees if needed. On the exam, be mindful: if a question asks "how many degrees of twist," compute θ then convert $\theta_{\text{deg}} = \theta_{\text{rad}} \times \frac{180^\circ}{\pi}$.
- **Uniform Cross-Section Assumption:** This formula assumes the shaft is the same J and G from one end to the other. If a shaft has sections of different diameter or material, you'd compute the twist for each section and add them. (The FE exam may include a question with a stepped shaft, but it will be manageable by segmenting the calculation.)
- **Torsional Compatibility:** If multiple shafts are connected in series (like a drive shaft connected to another), they share torque so each twists according to its own $L/(GJ)$ factor. This rarely gets asked explicitly, but conceptually it's like resistors in series (twist adds up).

Exam Handbook Search Cues (Not affiliated with or endorsed by NCEES): *angle of twist*, *torsional deformation*, *twist per unit length ($d\phi/dz$)*, *shear modulus G*, *torsional stiffness*

Equation Passport: *Angle of Twist Formula – computes the angular deflection (twist) between two points on a shaft under torque.* This is essentially the integration of the shear strain along the length, yielding the rotation angle. In a uniform shaft, it condenses to a simple formula:

Name and purpose: Angle of Twist Equation – Gives the relative rotation θ (in radians) of one end of a shaft relative to the other due to an applied constant torque T. Use this to find how much a shaft *twists* over a given length. For example, if one end is fixed and the other is torqued, θ is how far the free end rotates.

Professional equation: $\theta = \frac{T\,L}{G\,J}$, for a prismatic (uniform) shaft. Equivalently, one can express the *rate* of twist as $\frac{d\phi}{dz} = \frac{T}{GJ}$, and θ is just this rate integrated over length L.

Variables and units:

- θ – Angle of twist (radians). This is the relative rotation between the two ends of the length L. *(Remember: 2π radians = 360°, so if needed in degrees, convert after computing.)*
- T – Applied torque (N·m, lbf·ft, etc., consistent with units for J and G).
- L – Length of the shaft over which the twist is occurring (m, ft, etc.).
- G – Shear modulus of the shaft material (Pa in SI, psi in US units). It measures material stiffness in shear. For steel, for instance, G is around 75–80 GPa.
- J – Polar moment of inertia of the shaft's cross-section (m^4 or in^4). As in S01, J depends on geometry (using the same formulas for solid or hollow cross-sections).

Assumptions and scope:

- *Uniform material and cross-section:* G and J are constant along the length L. If not, the formula must be applied piecewise. The FE exam might explicitly tell you to consider segments if needed.
- *Elastic behavior:* The material stays in elastic range (so G is truly constant and no permanent twist). No slipping at connections – the twist is fully taken by elastic deformation.
- *Small deformations:* The angle θ is assumed small (in radians), which is usually true. This keeps the small angle approximation valid (shear strain = $r\theta/L$ essentially). In practice, even a few degrees twist over a meter is small enough for linear theory.
- *No initial slack or gaps:* We assume the shaft is already engaged – e.g., if a shaft had a loose connection, the first part of twist might just take up slack with little resistance, not covered by this formula. Exam problems typically don't involve such scenarios; they assume a solid connection.

Limit tests (sanity checks):

- If $T = 0$, then $\theta = 0$ (no twist with no torque – obvious but good to verify the formula gives that).
- If $L = 0$ (virtually no length, like two points on the same cross-section), $\theta = 0$ – a zero-length segment can't twist, also sensible.

- If G is extremely high (approaching a rigid material), $\theta \to 0$ for a given T. For instance, if you plug in an unrealistically large G, the formula yields a tiny angle – meaning a super stiff material hardly twists, which is correct.
- Check extremes: If you increase the length L, θ increases linearly. So a shaft twice as long twists twice as much under the same torque. If either J or G is doubled, θ is halved – a thicker or stiffer shaft twists less. No weird exponents or anything – it's all linear proportionality, which matches our physical intuition of a spring-like behavior in torsion.

Use vs. sibling equations: This torsion deformation formula is analogous to formulas for other modes: it's like the torsional version of $\delta = PL/(AE)$ for axial stretch or $\Delta = ML/(EI)$ (integrated form) for beam bending angles. Use $\theta = TL/(GJ)$ **when dealing with twist due to a moment**. Do not confuse it with bending deflection formulas or with the *torsional vibration* formula (which looks similar but involves polar mass moment and springs). If you have a **twisting spring (like a wire in torsion)**, sometimes they give a spring constant k in torsion; recall that $k_{\text{torsion}} = GJ/L$, so $\theta = T/k$. In other words, if you're given a torsional spring constant directly, use that. But usually, FE problems expect you to use GJ/L to find the effective spring constant yourself.

Common exam traps:

- *Forgetting to convert θ to degrees (or vice versa):* If the question asks for degrees of twist, and you compute $\theta = 0.05$ (which is in radians), giving "0.05°" would be wrong – 0.05 rad is about 2.87°. Always check if the answer needs a specific unit. Radians are "unitless" in calculations, but when interpreting results, be clear.
- *Using wrong G value or mixing up E and G:* E (Young's modulus) is for normal (axial/bending) deformation, while G is for shear/torsion. They are related by $G = \frac{E}{2(1+\nu)}$ if needed, but the exam usually provides G or enough info. Don't plug in E where G is needed – a classic mistake if you're rushing.
- *Segmented shaft confusion:* If a shaft has two different sections (say half is solid, half is hollow or a different material), you must compute twist for each and add. A trap is to average J or G somehow – that's incorrect. The correct approach is piecewise: $\theta_{\text{total}} = \theta_1 + \theta_2 = TL_1/(G_1J_1) + TL_2/(G_2J_2)$. The exam might simplify this by giving numeric values, but conceptually, don't combine different sections into one formula blindly.
- *Units mix-ups in G or L:* G might be given in, say, GPa and length in mm. Convert G to a consistent base unit (e.g., GPa to N/m^2 and mm to m) *or* convert L to a unit matching G (e.g., mm and use G in N/mm^2). If you end up with θ extremely tiny (like 1e-6) when you expected a few degrees, check if L was input in meters while G was in Pa and dimensions in mm by mistake.
- *Confusing torque units:* In some problems, you might be given torque in say N·m but use J in cm^4 – then G might be given in GPa. It's easy to jumble units here. A good practice: convert everything to base SI ($N \cdot m, m, Pa, m^4$) or everything to base USCS (lbf·in, in, psi, in^4) before plugging in.

Footnotes: *Angle vs. Polar Coordinates* – Sometimes θ (twist angle) is denoted as ϕ in textbooks (and $d\phi/dz$ for twist rate). In the exam reference, they used ϕ for the total twist and $d\phi/dz$ for rate of twist. Don't let notation confuse you: θ here is the same thing. *Sign conventions* – If you assume a direction for torque (clockwise vs counterclockwise), one end's rotation relative to the other could be positive or negative. But since FE problems usually just ask "how far" (magnitude), give a positive answer with an indication of degrees or radians. *Shear modulus sources* – If not given G directly, you might recall or find in the handbook typical values (e.g., steel ~79 GPa, aluminum ~26 GPa, etc.), or you might be given E and ν to compute G. That's fair game: remember $G = E/[2(1+\nu)]$ if needed. However, many exam problems simplify by giving G.

Variations and related forms: If the shaft is *non-uniform* (varying cross-section or material), integrate the general form: $\theta = \int_0^L \frac{T\,dz}{G(z)J(z)}$. This is just the calculus version, but practically, it means sum up segment twists. A related concept is **torsional strain energy**: the energy stored by twisting is $\frac{1}{2}T\theta = \frac{T^2L}{2GJ}$. While the FE Mechanical might not directly ask for strain energy, understanding it reinforces that a stiffer shaft (big GJ/L) stores more energy for the same twist angle (like a stronger spring) or conversely twists less for same energy. Another variant: **Twist per unit length** is $d\theta/dL = T/(GJ)$ – sometimes an exam question might give you "a bar twists by X radians over Y meters" and ask for torque, effectively having you use $T = GJ(d\theta/dL)$. Also note the relationship to *torsional stiffness* k_t: comparing with linear springs ($F = k\delta$), here $T = k_t\theta$. Indeed $k_t = GJ/L$. So if they ever give you a torsional spring constant, you can use that directly: $T = k_t\theta$. **Typical values:** For a 1 m long, 2 cm diameter steel rod under 100 N·m torque, $\theta = TL/(GJ)$ comes out to maybe a few degrees. So angles are usually not huge (unless dealing with very soft materials or long shafts). If you calculate an angle of, say, 50 degrees for a steel shaft with a reasonable torque, double-check inputs – it's probably too high unless the shaft is extremely thin or long.

Special notes (calculator): Calculating θ is again straightforward arithmetic. One nuance: if you need the answer in degrees, you might do the rad→deg conversion on the calculator by multiplying by $180/\pi$. All allowed calculators can handle this, but remember to use the π built-in (don't approximate 3.14 by hand). Also, keep track of scientific notation if J is very small (for instance, J of a small-diameter rod might be 1×10^{-10} m^4 order of magnitude, making $T/(GJ)$ a large number, but θ might still be moderate because L might not be too big). It's easy to make a slip when entering such exponents. If using the Casio, the fraction template is helpful: enter T, L in numerator, and G, J in denominator to avoid forgetting parentheses. For multi-segment problems, calculate each segment's θ separately then sum (your calculator's memory registers or just writing intermediate values will help).

Explanation: The angle of twist formula is used to find out how *far* something rotates when twisted. Think of tightening a screw with a wrench: the wrench twists, but so does the screw (like a torsional spring). Here, if the "screw" is actually a shaft, $\theta = TL/(GJ)$ tells how much one end turns relative to the other. In FE exam problems, you might be given a gear or shaft that can only twist so much before misalignment occurs, and asked if a certain torque will exceed that – you'd compute θ to find out. Or you might be asked the twist in a drive shaft between an engine and generator. This formula basically comes from integrating the shear strain over the length: each small slice of shaft twists a tiny bit ($d\phi$), and adding them gives total ϕ (or θ). It's straightforward if you identify the parameters: find T, L, G, J for the shaft and plug in.

Analysis (step-by-step usage): Using $\theta = \frac{TL}{GJ}$ is similar to using Hooke's law in rotational form: 1. **Identify the input values:** From the problem, pick out the torque T (it might be directly given, or you might have to compute it from a power and speed, etc., but likely given in a statics context). Note the length L of the portion of shaft in question. Identify the material (to get G; if the problem doesn't specify, assume a common material like steel with known G, or they might directly give G or a table). Determine the shaft's cross-section to find J (if it's a standard shape like a solid circle or pipe, you might compute J; sometimes the exam provides J in the question). 2. **Check units:** Convert everything to consistent units (this cannot be overstated!). If T is 500 lbf·ft and J you calculate in in^4, convert T to lbf·in (multiply by 12) or J to ft^4 (divide by 12^4), etc. For SI, ensure L is in m if G is in Pa. 3. **Plug into $\theta = TL/(GJ)$:** It's straightforward number crunching once units match. For example, say $T = 2000$ N·m, $L = 3$ m, $J = 5 \times 10^{-5}$ m^4, $G = 80 \times 10^9$ Pa (80 GPa for steel). Then $\theta = \frac{2000*3}{(80\times10^9)(5\times10^{-5})}$. *Calculate numerator* $= 6000$, *denominator* $= (80 \times 10^9)(5 \times 10^{-5}) = 4 \times 10^6$, so $\theta = 6000/4e6 = 0.0015$ radians. That's about $0.0015(180/\pi) \approx 0.086°$. *A tiny twist, which seems reasonable for a thick steel bar under 2000 N·m. 4. Interpret the result: If θ is asked in degrees, convert it. If the question asks something like "is this acceptable if the max allowed twist is 1° per meter?" you'd compare your result to that criterion. Because torsional deflection might matter for alignment in machinery, sometimes the exam could give a max allowable twist per length (though that's more of a design question; FE mostly sticks to calculation). 5. Check for multiple segments: If the problem had, say, a composite shaft (half steel, half aluminum in series), compute $\theta_{\text{steel}} = TL_1/(G_{\text{steel}}J_1)$ and $\theta_{\text{alum}} = TL_2/(G_{\text{alum}}J_2)$, then $\theta_{\text{total}} = \theta_{\text{steel}} + \theta_{\text{alum}}$. Make sure to use the correct G and J for each segment. 6. Double-check extremes:** If you got a surprisingly large angle, perhaps the shaft was very slender or L huge. Does that make sense? If a number looks off, revisit step 2 (units!). For instance, if someone accidentally uses G in GPa as if it were Pa, they'd undercompute θ by a factor of 10^9. Conversely, using mm instead of m for L would overcompute θ by 1000x. These errors are easy to make, so use physical intuition – a steel rod usually won't twist tens of degrees under a modest torque unless it's extremely thin or long.

In summary, $\theta = TL/(GJ)$ is your friend for any torsion deformation question. It's straightforward: just remember it outputs radians. Use it when you see torque + geometry + "how much twist/rotation." It's essentially telling you how "springy" the shaft is in torsion.

K08.T05.S03 – Shear Strain Distribution in Solid vs. Thin-Walled Shafts

Principle Introduction: *Torsion causes a shear strain inside the material, which describes how much distortion (angular deformation) each layer of the shaft undergoes.* Understanding the distribution of shear strain (and equivalently shear stress) across a cross-section is important conceptually and for design. Here's what you need to know for the exam:

- **Linear Strain Distribution in Solid Shafts:** In a solid (or thick-walled) circular shaft, shear strain γ increases linearly from the center to the surface. The material at the center experiences no shear strain (it essentially doesn't twist), while the outer material experiences the maximum shear strain. This is intuitive if you imagine twisting a rubber rod – the outer surface swirls a lot, the core barely moves.
- **Shear Strain and Shear Stress Relationship:** In the linear elastic regime, $\tau = G\,\gamma$. So a linear strain distribution means a linear stress distribution as well. This ties back to subtopic S01: $\tau(r) \propto r$ is equivalent to $\gamma(r) \propto r$, since G is constant. The proportionality constant between stress and strain is G (shear modulus).
- **Twist per Unit Length ($d\phi/dz$):** All cross-sections of a uniform shaft rotate together such that the twist per unit length is constant along the shaft. This twist rate $d\phi/dz$ is the slope of the twist angle along the shaft's axis, and it is directly related to the shear strain at any radius: $\gamma(r) = r\,(d\phi/dz)$. In other words, if you know the shaft twists by ϕ radians over length L, then $d\phi/dz = \phi/L$, and at a radius r, $\gamma = r\,\phi/L$. This formula (which comes from geometry of deformation) produces that linear pattern: as r grows, γ grows linearly.
- **Thin-Walled Tubes – Nearly Uniform Strain:** In a very thin-walled hollow shaft (like a pipe with thin walls), the shear strain across the thickness is almost uniform. Essentially, *all* material in the thin wall is at approximately the same shear stress and strain. The formula for shear stress in a thin-walled circular tube simplifies accordingly: $\tau \approx \frac{T}{2tA_m}$ (where t is wall thickness and A_m is the cross-sectional area enclosed by the mean radius). This formula yields one value of τ (and hence γ) that is considered constant through the wall thickness. The "thin-wall" assumption is typically valid when the wall thickness t is less than about 10% of the mean radius (so $t < 0.1r_{\text{mean}}$).
- **Practical Impact:** The difference between solid and thin-walled assumptions can show up in exam questions asking about relative stress or weight efficiency. A thin-walled shaft of the same outer radius c concentrates material further out (where it's more effective for resisting torsion), so it can be more efficient. But you use the uniform stress assumption for thin walls to simplify calculations. If a problem specifies a tube with *thin* walls, you might directly use the thin-wall torsion formula without computing J. If it doesn't specify thin, you might need the full J formula and treat it as thick-walled with the linear distribution.

Exam Handbook Search Cues (Not affiliated with or endorsed by NCEES): *shear strain*, *torsional strain*, *strain distribution*, *thin-walled torsion*, *hollow shaft*

Shear strain/stress distribution in circular shafts. (a) In a solid shaft, shear strain γ (and shear stress τ) increases linearly from zero at the center to a maximum at the outer surface. The blue lines in (a) illustrate relative shear stress magnitude at various radii (longer line = higher τ). (b) In a thin-walled hollow shaft, the shear stress is approximately uniform across the wall thickness. The red lines in (b) are equal in length at the inner and outer wall, indicating nearly constant τ through the thin wall. In both cases, the direction of shear stress is tangential to the cross-section (not shown explicitly), and it reverses on opposite sides of the shaft (one side experiences clockwise shear, the other counter-clockwise). The key takeaway: solid shafts have a **radial gradient** of shear, whereas thin tubes have an **even distribution** through the wall.

Diagram Passport: *Torsional Shear Distribution Diagram – visualizes how shear stress/strain vary within a round cross-section.*

- **Axes and quantities:** In diagram (a), imagine the horizontal axis as the radius r from the center (0 at center to c at outer surface). The vertical "spikes" represent shear stress magnitude $\tau(r)$ at that radius. It's a linear increase – effectively a triangular distribution if you plotted τ vs r. In diagram (b), the horizontal axis spans the wall thickness of a hollow tube. The red spikes at the inner and outer surfaces are of equal length, showing τ is essentially the same at both inner and outer boundaries of a thin wall. (If the wall wasn't thin, τ at inner vs outer might differ slightly – but for $t \ll radius$, difference is negligible.)

Key regions and thresholds:

- For the solid shaft (a): Center ($r = 0$) is a key point (zero stress/strain). Outer surface ($r = c$) is the critical point (max stress/strain). Any radius in between has proportional values. There's no abrupt changes – just a smooth ramp up.
- For the hollow shaft (b): The region of interest is the wall thickness itself. In a true thin-wall assumption, the stress is uniform across that thickness. The "mean radius" (midway through thickness) is often used for calculations (A_m in the thin-wall formula corresponds to that). If the wall is not extremely thin, a more exact solution would show a slight drop from outer to inner radius (higher at outer if wall is thick), but exam problems will clarify if thin-wall approximation is intended. The threshold often cited is $t < 0.1r$ for thin-wall to be valid – beyond that, you should use the full formula with J and accept that stress at inner is somewhat lower than at outer.

How to read it (exam-style): If a question asks *qualitatively* "where is the shear stress highest in a shaft under torsion?" – the answer for a solid or thick-walled shaft is *at the outer surface*. The diagram (a) makes that obvious: the longest blue line is at the outer edge. If asked "what is the shear stress at the center?" – it's zero (the diagram shows nothing at the center). For a thin-walled tube, if asked "compare shear stress at inner vs outer surface," the answer: nearly the same (diagram (b) shows equal red lines). If given a torque and asked to compute τ in a thin tube, you might use $\tau = T/(2A_m t)$ to get that uniform value. If the problem instead expects using $\tau = Tr/J$, you would plug in r_{outer} for max but since inner is almost same, either could be used with essentially same result if thin. The exam may explicitly say "use thin-wall assumption" or give a hint like "very thin tube" to cue you to use the simplified formula.

Common misreads:

- *Thinking the center of a solid shaft carries torque* – Actually, the center carries zero shear stress (though it's along for the ride). Some might think the whole cross-section shares the load equally; instead, stress is lower toward the middle. The torque is mostly carried by outer material.
- *Forgetting that strain follows the same distribution as stress (just scaled by $1/G$).* If asked about "shear strain at a certain radius," you can either compute stress then divide by G, or directly use geometry: $\gamma(r) = r\left(T/(GJ)\right)$. Either way, it's proportional to r. Sometimes a question might give you the twist per length and ask for strain at outer fiber: just multiply twist rate by outer radius.
- *Misapplying thin-wall formula to a thick tube:* If t is not very small relative to radius, using $\tau = T/(2A_m t)$ can introduce error. In such cases, the problem usually expects using the general J formula. For example, if you have a tube with $r_o = 100$ mm and $r_i = 50$ mm, that's a thick wall ($t = 50$ mm, which is 0.5 of the outer radius). The correct approach: find $J = \frac{\pi}{2}\left(r_o^4 - r_i^4\right)$ and then $\tau_{max} = Tr_o/J$. The thin-wall formula would overestimate J (underestimate stress) in that case. So heed clues: "thin-walled" phrase should be present to use the simplified approach.
- *Confusing shear flow q with shear stress τ in thin walls:* In some contexts (usually in advanced topics or civil engineering), they use $q = \tau t$ (shear flow). The formula $T = 2A_m q$ is essentially the same as $T = 2A_m(\tau t)$, which leads to $\tau = T/(2A_m t)$. If you see q mentioned (unlikely in FE Mechanical depth), just remember q is not asked; we want τ. Stick to the τ form unless specifically asked about shear flow.

Footnotes: In these formulas, A_m is the area enclosed by the mean radius of the tube (the area of a circle of radius r_{mean}). For a thin tube, $r_{\text{mean}} \approx r_i + t/2 \approx r_o - t/2$. If the problem provides inner and outer diameters, you can compute $A_m = \pi r_{\text{mean}}^2$. But an easier way: $A_m \approx \frac{\pi}{4}\left(D_{\text{outer}}^2 + D_{\text{inner}}^2\right)$ – the average of areas, which for thin walls is basically the mid-area. Some exam references define A_m that way. *Shear strain units* – Shear strain γ is dimensionless (radians, basically). If a numeric value is needed, it might be a small decimal (like 0.001 rad of distortion which is about 0.057°). It's rare for FE to ask directly for γ; more often they'll go for τ or θ. But concept questions might mention it. *Material yielding in torsion* – If the shear stress exceeds material shear yield strength, plastic deformation starts at outer surface first (since τ is highest there) and spreads inward as torque increases. The exam likely won't dive into elastic-plastic torsion, but it's good to know the linear distribution holds until yielding; after that, the distribution evens out (in fully plastic torsion, stress is uniform across the yielded section). We won't need those details for FE, but it reinforces why linear is an elastic assumption.

Variations and related forms: The **thin-walled torsion formula** $\tau = \frac{T}{2A_m t}$ is a special case worth highlighting. It's derived by noting that in a thin wall, shear stress is almost constant, so T is carried by the entire cross-section via $T \approx \tau(2A_m t)$ (where $2A_m$ is effectively the first moment of area of the tube's wall about center). This formula is a quick way to bypass calculating J for a thin tube. If we solved $\tau = Tr/J$ for the thin tube, using $J \approx 2\pi r_{\text{mean}}^3 t$ (approximate J for thin tube), we'd get basically the same result. Another related concept: **angle of twist for thin-walled tube** – you can still use $\theta = TL/(GJ)$, but if you have the choice of using the thin-wall J (approximate) or doing it via A_m, it's typically easier to just compute J anyway. However, note that a thin-walled section often twists more *for the same cross-sectional area* than a solid one, because J is smaller if the material is all near the outer radius? Actually, for equal outer radius and cross-sectional area, the hollow might have higher J (material pushed outwards) – which is why hollow shafts are efficient. So sometimes a question might ask, *for equal weight, which is stronger in torsion: solid or hollow?* The answer is usually hollow (because you remove inner, low-stress material, concentrating material at larger radii increasing J per area). Keep that intuition: material far from center is gold for torsion resistance.

Another variant: **Non-circular sections** – The exam *could* ask conceptually: "Why can't we use $\tau = Tr/J$ for a square bar?" The answer: non-circular cross-sections don't have a simple J and the stress distribution is not linear or purely radial. They warp (cross-section doesn't remain plane). But if needed, the exam would give the formula (Saint-Venant's theory) or ask which cross-section (circle vs square) is better for torsion (it's circle, because it doesn't warp and has higher J for same area). For completeness, **rectangular bars** have a max shear at the mid of longer side, not at corners; but again, that's beyond normal FE depth unless a formula is provided.

Special notes: If you need to calculate something like shear strain γ from scratch, you could use $\gamma = \tau/G$. For example, if asked "what is the shear strain at the outer surface of the shaft?", you can find $\tau_{\max}$ and divide by G. Make sure your calculator is in a mode that can handle small numbers – γ might be on the order of 10^{-3} or 10^{-4}. Also, if entering the thin-wall formula into a calculator, it might be easier to compute A_m first, then do $T/(2A_m t)$. Keep track of those parentheses: $2A_m t$ in the denominator means $2 \times A_m \times t$. A potential calculator pitfall: hitting the π button at the wrong time or squaring the radius incorrectly – double-check A_m calculations separately if time permits.

Explanation: This subtopic is more conceptual – it ensures you understand *where* the maximum stress/strain occurs and how things differ for different geometries. On the exam, you might see a question like: "A solid shaft and a hollow thin-walled shaft have the same outer diameter and material. Which one experiences higher shear stress under the same torque?" Knowing the distribution, you'd say: the hollow thin-walled shaft will have *almost all material at high radius*, so it might actually have a **lower** shear stress for the same torque if the cross-sectional area is the same – because J is larger for the hollow (counterintuitive to some, but a thin hollow can be stronger in torsion per unit weight). Another question could be: "At what radial position is the shear stress in a circular shaft under torsion equal to half the maximum?" Since it's linear, that's just at half the outer radius (because $\tau \propto r$). Or they might simply test if you know that at the center, shear stress is zero. A qualitative question might say: "Describe the variation of shear strain in a circular rod under torsion." You'd answer: it increases linearly from center to circumference, zero at center, max at circumference. This is often presented in mechanics classes by drawing the famous diagram we just discussed. For thin-walled members, the exam might not ask you to derive anything, but could ask to use the thin-wall formula to compute stress, or compare it with a thick-wall result.

Understanding this distribution also helps avoid mistakes: for instance, you know to use outer radius for max stress, not something like half the radius unless specifically asked for that location. And if a problem ever gave you the shear strain at the outer fiber and asked for torque, you could work backwards: $\gamma_{\max} = c\left(T/(GJ)\right)$ so $T = \gamma_{\max} GJ/c$. This is a bit esoteric, but it shows the power of understanding the linear relation.

Analysis: Let's connect the dots between stress, strain, and twist in a solid shaft: - The twist per unit length is $d\phi/dz = T/(GJ)$, a constant for a given torque and shaft (like saying "X radians per meter"). - A material fiber at radius r will undergo a shear strain $\gamma(r)$ equal to that twist rate times r: $\gamma(r) = r\frac{d\phi}{dz}$. This makes sense dimensionally: radians per meter times meters gives radians (strain in rad). - Plugging $d\phi/dz = T/(GJ)$, we get $\gamma(r) = \frac{Tr}{GJ}$. And if we multiply that by G, we indeed recover $\tau(r) = \frac{Tr}{J}$. So it's all consistent. - Now, at $r = 0$, $\gamma(0) = 0$. At $r = c$, $\gamma_{\max} = \frac{Tc}{GJ} = \frac{\tau_{\max}}{G}$. So if you know $\tau_{\max}$, just divide by G to get the outer shear strain. If G is large (stiff material), even a high stress gives a small strain (the material doesn't shear much). If G is low (rubber-like), a modest stress yields a large shear strain (twists like taffy). - For a thin-walled tube, what changes? The formula $\tau = T/(2A_m t)$ can be rearranged to find an equivalent J: since $\tau \approx \frac{T}{2A_m t}$ and also $\tau \approx \frac{Tr_{\text{mean}}}{J}$ (taking $r \approx r_{\text{mean}}$ since stress is almost constant), one can infer $J \approx 2A_m t r_{\text{mean}}$. Indeed, the exact formula for a thin tube's J is $2\pi r_{\text{mean}}^3 t$ (for a circular tube). $2A_m t$ is $2(\pi r_{\text{mean}}^2)t = 2\pi r_{\text{mean}}^2 t$, and multiplying by r_{mean} gives $2\pi r_{\text{mean}}^3 t$, matching that. So the thin-wall formula is just a shortcut. If you use it, you're effectively skipping computing J. You'll get the same answer either way if the wall truly is thin. - From strain perspective: in a thin wall, every point in the thickness is roughly at the same radius ~ r_{mean}, so $\gamma \approx r_{\text{mean}}\left(T/(GJ)\right)$ for the whole wall. There isn't a significant r difference within the wall (inner vs outer), so we treat γ constant. If the exam problem is not pushing high accuracy, this is fine. If high accuracy were needed, you could always do inner and outer with $\tau = Tr/J$ to see the slight difference. - *Numerical example:* Suppose we have a solid shaft, radius 0.1 m, torque 500 N·m, $J = \pi(0.1^4)/2 = 1.57 \times 10^{-4}$ m^4. Then $\tau_{\max} = 5000.1/(1.57e-4) \approx 318{,}000$ Pa *(318 kPa). At* $r = 0.05$ *m (half radius),* $\tau = half$ *of that, ~159 kPa. At center, 0. Now a thin tube with same outer radius 0.1 m but inner radius 0.095 m (thin 5 mm wall).* $r_{\text{mean}} \approx 0.0975$ *m,* $A_m = \pi(0.0975^2) = 0.0299$ m^2. *Using thin-wall* $\tau = T/(2A_m t)$*:* $t = 0.005$ *m, so* $2A_m t = 2 * 0.0299 * 0.005 = 0.000299$ m^3. *Then* $\tau \approx 500/0.000299 = 1.67 \times 10^6$ Pa *(1.67 MPa). Now, if we used the full formula:* $J = \frac{\pi}{2}(0.1^4 - 0.095^4) \approx 1.56 \times 10^{-4}$ m^4 *(almost the same as solid in this case because thin difference), and* $r_o = 0.1$, $\tau_{\max} = 5000.1/1.56e-4 = 320kPa(0.32MPa)$. Wait, the thin-wall gave 1.67 MPa, which is way higher. Why? Because our "thin" wasn't extremely thin (5% of radius). Actually, 5 mm on 100 mm radius might not qualify as thin by the 0.1r rule (0.005 vs 0.0975 ~ 0.05, which is less than 0.1, oh it is thin by that measure). Hmm, check the arithmetic: A_m for mean radius ~0.0975 should be $\pi(0.0975)^2 = 0.0299\text{m}^2$. $2A_m t = 20.02990.005 = 0.000299$. $500/0.000299 = 1.67e6$Pa. That seems inconsistent with the J method result of 320e3 Pa. The discrepancy is because the thin-wall formula as I applied it is not correct for only moderately thin – I might have mistaken something. Actually, let's double-check the "thin-wall" scenario properly: - Outer radius 0.1, inner 0.095: mean radius ~0.0975, area ~0.0299, thickness 0.005. - The exact thin-wall formula from the handbook is $\tau = \frac{T}{2A_m t}$. If I trust that, the 1.67 MPa would be the result. But my exact calc with J gave 0.32 MPa. Clearly, 5 mm wall on 100 mm radius might not be "thin enough" and the formula might be meant for extremely thin? Actually 5% is usually considered thin. There is likely a mistake: Ah, I see it: I used $T = 500\text{N} \cdot \text{m}$ (which is 500 N·m, that's 500 ?), in base units $T = 500\text{N} \cdot \text{m}$, $2A_m t$ came out 0.000299 m^3, dividing gave 1.67e6 Pa = 1.67 MPa. The J method gave 0.32 MPa, which is five times smaller. Something's off.

Realize: The J for the hollow is only slightly less than solid (since inner radius is close to outer). Did I compute it right? $J = \frac{\pi}{2}(0.1^4 - 0.095^4)$. $0.1^4 = 1e-4$, $0.095^4 = 0.000081$, difference ~0.000019, half * pi = 0.5*3.1416*0.000019 = 0.0000298 (2.98e-5). Wait, that's 2.98e-5, not 1.56e-4. I need to recalc: Actually, $0.1^4 = 0.0001$, $0.095^4 \approx (0.10.95)^4 = 0.0001 * 0.95^4$. 0.95^4 0.8145. *So* 0.00010.8145 = 0.00008145. Difference: $1e-4 - 8.145e-5 = 1.855e-5$. Times $\pi/2$: $= 1.855e-5 * 1.5708 = 2.915e-$

5. Yes, $J \approx 2.92e-5\ m^4$ (which is an order smaller than my earlier mistaken 1.56e-4 – I mis-copied the solid's J presumably).

Now $\tau_{max} = 500 * 0.1/2.915e-5 = (50)/2.915e-5 = 1.715e6Pa = 1.72MPa$

Ah, that matches the thin-wall calculation: **1.67 MPa**. Good—consistency restored. The earlier **320 kPa** was wrong because I used an incorrect J. So indeed, the thin-wall formula matches the correct J-based approach. **Moral:** if done correctly, both approaches agree for thin-wall cases. It's always better to trust the exact Jif you can compute it, but the thin-wall approximation saves time and is easier to use on a calculator for extreme ratios.

- So, analysis shows linear distribution for solid: at half radius, half the stress, etc. For thin tube: essentially uniform. If the exam expects a qualitative understanding, you won't need to do an example like above in detail, but it's behind the scenes.

To wrap up: In a solid or thick shaft, remember **outer surface = max stress/strain** and **center = zero**. In a thin-walled tube, assume **uniform stress across the wall** (so inner and outer surfaces have ~same stress). Use the appropriate formula accordingly. This helps avoid errors like using the wrong radius or mis-estimating stress in hollow sections. Understanding these distributions builds intuition: for instance, you wouldn't worry about material near the center of a shaft for torsion – it's not contributing much. And that's exactly why hollow shafts exist!

Finally, always link back to the big picture: stress causes material failure (so $\tau_{\max}$ vs shear strength matters), strain causes deformation (so θ matters for alignment). With torsion, you often check both: ensure $\tau_{\max}$ is under the allowable and θ is within functional limits. The FE exam might isolate one or the other in a question, but as an engineer, keep both in mind. That way, even if a problem gives you more info than needed (like material strength when they only ask for angle), you won't be thrown off – you'll recognize which torsion aspect is being tested.

Topic 06 - Stress and Strain Caused by Shear

Topic Introduction: In beam and material strength problems on the FE Mechanical Exam, shear plays a crucial role alongside tension, compression, and bending. **Shear stress is the internal tangential force per unit area that tends to make material layers slide relative to one another, while shear strain quantifies the resulting angular deformation produced by that shear**. This topic covers how shear stress and strain relate (via the shear modulus), how to calculate transverse shear stress distribution in beams (including shear flow in built-up members), and the sign conventions engineers use for shear forces in beam diagrams. Mastering these concepts is important for exam questions asking for shear stress at a given cross-section, computing material deformation under shear, or interpreting shear force diagrams correctly. Typical questions might give you a material's **Young's modulus** and **Poisson's ratio** and ask for the **shear modulus**, or provide a beam's cross-section with an internal shear force and ask for the shear stress at a certain location. With a solid grasp of shear relationships and conventions, you'll handle these problems efficiently and avoid common pitfalls like unit mix-ups or sign errors.

K08.T06.S01 – Shear Stress–Strain Relationship (Modulus of Rigidity)

Principle (Hooke's Law in Shear): In the linear elastic range of a material, shear stress is directly proportional to shear strain, analogous to Hooke's law for axial loading. Key points include:

- **Linear Elastic Behavior:** Under small deformations, a material deforms such that **shear stress** (τ) is proportional to **shear strain** (γ). This linear relationship defines the **shear modulus** G (also called *modulus of rigidity*), a material constant.
- **Shear Strain Definition:** Shear strain γ is the angular change (in radians) between orthogonal lines in a material under shear load. Imagine a small element originally shaped as a right angle; when shear is applied, that angle changes by γ (measured in radians – effectively dimensionless).
- **Shear Modulus G:** The slope of the shear stress–strain line is G. A higher G means the material is "stiffer" against shearing deformation. **Shear modulus** is not an independent property for isotropic materials – it is related to Young's modulus E and Poisson's ratio ν. In fact, once E and ν are known, G is fixed by the relation: $G = \frac{E}{2(1+\nu)}$. This formula shows, for example, that materials with higher Poisson's ratio (ν) will have a lower G for a given E.
- **Typical Values:** For most metals, ν ranges ~0.25–0.35, so shear modulus is on the order of 0.4 * E. For instance, steel with $E \approx 200$ GPa and $\nu \approx 0.30$ has $G \approx 77$ GPa. This means steel's resistance to shearing deformation is about 40% of its resistance to tensile deformation. Aluminum's E (~69 GPa) and ν (~0.33) give $G \approx 26$ GPa, reflecting that aluminum is more easily sheared than steel.

Exam Handbook Search Cues (Not affiliated with or endorsed by NCEES): *shear modulus*, *modulus of rigidity*, *τ = Gγ*, *Poisson's ratio* (ν), *G = E/(2(1+ν))*.

Equation Passport: Shear Stress–Strain Law – relates **applied shear stress** to **resulting shear strain** in the elastic region of a material.

Formal Name and Purpose: Shear Stress–Strain Relationship (Hooke's Law in Shear) – Computes the deformation response (γ) of a material to an applied shear stress τ (or vice versa), using the material's shear stiffness G. It answers: *"If I apply this much shear stress, how much shear strain (distortion) occurs?"*

Professional Formulation:
$\tau = G\gamma$ or equivalently $\gamma = \frac{\tau}{G}$.

Variables and Units:

- τ: shear stress in the material – internal frictional force per unit area trying to slide layers, **Units:** Pa (N/m²) in SI, or psi in US Customary.
- γ: shear strain – angular distortion of a right angle, **Units:** radians (dimensionless).[^note1]
- G: shear modulus (modulus of rigidity) – material stiffness in shear, **Units:** Pa or psi (same units as stress).

Assumptions and Scope:

- Material is **linear elastic** and **isotropic** (same properties in all directions). The linear relation τ = Gγ holds up to the proportional limit.
- **Small deformations:** γ is a small angle (in radians), so that linear approximation is valid (no geometric nonlinearities).
- Isotropy implies a fixed relation between G, E, and ν: $G = \frac{E}{2(1+\nu)}$. This relation is built into most exam problems unless told the material is non-isotropic (rare in FE context).
- **Elastic range only:** Beyond yield, the relationship won't be linear; however, most FE problems stick to elastic behavior unless explicitly dealing with plasticity.

Limit Checks:

- As $G \to \infty$ (extremely rigid material), the equation suggests $\gamma \to 0$ for any finite τ – indeed an infinitely stiff material would hardly deform under shear.
- As $G \to 0$ (extremely soft or no shear resistance, like a fluid), even a tiny τ would produce a huge γ (or for a given γ, required τ → 0). This makes sense: materials with very low shear modulus (rubbers, gels) shear easily.
- If τ = 0, then γ = 0 (no shear stress, no shear strain, no surprise). If γ = 0 (material is not distorting), τ must be zero or the material is perfectly rigid.

Use vs. Sibling Equations: Use this shear form of Hooke's law instead of the axial stress–strain formula (σ = Eε) when dealing with **shear** deformations (like torsion of circular shafts, shear in beams, or direct shear in joints). It complements the axial formula:

both are special cases of Hooke's law along different directions. **Do not** use $\sigma = E\varepsilon$ for shear problems; use $\tau = G\gamma$ instead.

Common Exam Pitfalls:

- **Unit Mix-Ups:** Ensure consistent units for stress and modulus. If E is given in GPa, convert to Pa when computing G, or work entirely in one unit system. Remember that 1 GPa = 1000 MPa = 10^9 N/m². A frequent mistake is plugging E in Pa and ν dimensionless to get G, but then using τ in MPa without converting – this yields a γ off by a factor of 10^6! [^note2]
- **Using Wrong Material Property:** Don't plug **E** (Young's modulus) in place of **G** for shear calculations. For example, calculating angle of twist in a shaft or shear deflection in a beam requires G; using E by accident will underestimate deformation (since E > G for any ν > 0).
- **Poisson's Ratio Confusion:** The formula $G = \frac{E}{2(1+\nu)}$ might appear in a problem. Students sometimes mis-remember it as $E = 2G(1+\nu)$ (which is actually the same rearranged) or confuse it with the bulk modulus formula $K = \frac{E}{3(1-2\nu)}$. Double-check that the signs match the correct formula for G on exam day.
- **Shear vs. Axial Strain:** Shear strain γ is an angle (radians) – it's not the same as normal strain ε. Be careful to use the right modulus with the right strain type. If a problem gives an **angular** deformation (like twist angle or distortion in degrees), convert it to radians and relate to τ with G, not to σ with E.

Footnotes:

[^note1]: **Shear strain units:** Although often stated as "dimensionless," shear strain represents an angle (usually in radians). For small angles, radians ≈ shear displacement/length. Always convert degrees to radians if using in formulas.

[^note2]: **Consistent units example:** If $E = 30 \times 10^6$ psi and $\nu = 0.3$, then $G = \frac{30\times10^6}{2(1+0.3)} \approx 11.5 \times 10^6$ psi. Use psi for τ as well. If converting to SI: $E \approx 200$ GPa $= 2 \times 10^{11}$ Pa, so $G \approx \frac{2\times10^{11}}{2(1.3)} \approx 7.7 \times 10^{10}$ Pa $= 77$ GPa. Use Pascals for τ correspondingly.

Variations and Related Forms:

- **Alternate Form of Hooke's Law:** The full 3D Hooke's law relates shear components and normal components. In matrix form for isotropic materials, $\gamma_{xy} = \tau_{xy}/G$ pairs with normal strain formulas $\varepsilon_x = \frac{1}{E}\left[\sigma_x - \nu\left(\sigma_y + \sigma_z\right)\right]$. The exam might not require writing the matrix form, but know that $\tau = G\gamma$ is one piece of the generalized Hooke's law.
- **Computing G from E, ν:** As noted, $G = \frac{E}{2(1+\nu)}$ is a very likely needed formula. For example, if a problem gives a material's E and Poisson's ratio, you might need to compute G to plug into a torsion or shear formula. This relationship holds for isotropic materials (most metals, common engineering materials). If ν is ~0.30, note that $G \approx 0.385E$. If ν is ~0.25, $G \approx 0.4E$. **Remember:** higher ν (more lateral expansion under tension) slightly lowers the shear stiffness.
- **Modulus of Rigidity vs. Young's Modulus:** Some questions might indirectly test understanding by giving **two** of the three values (E, G, ν) and asking for the third. For instance, *"A material has a Young's modulus of 10,000 ksi and a shear modulus of 4,000 ksi. What is its Poisson's ratio?"* You'd rearrange $G = \frac{E}{2(1+\nu)}$ to find $\nu \approx 0.25$ here.

Special Notes: Calculation-wise, entering the formula into your calculator is straightforward. Just be mindful of parentheses: e.g. for $G = \frac{E}{2(1+\nu)}$, compute the denominator as a whole. On a scientific calculator, you might type: E_value / (2 * (1 + nu_value)). If you're computing shear strain, say $\gamma = \tau/G$, remember to use consistent units – it's often easiest to convert all values into SI or all into US Customary before dividing.

Explanation & Analysis: Shear stress–strain behavior is essentially telling us *how much a material "twists" or distorts under a given shear load*. In an FE exam problem, you might use this relationship in contexts like: **torsion of a circular shaft** (where the angle of twist per length is $\gamma = \tau/G$) or **direct shear** (like a pin in double shear: if you know the shear deformation and geometry, you could find τ). Let's break down the relationship:

- **Physical Meaning of τ = Gγ:** Imagine pressing down on a rectangular block glued to a table – you apply a shear stress τ along the top surface. The block deforms into a parallelogram shape: the top face shifts relative to the bottom by some small angle γ. The shear modulus G tells you how steep the stress-strain curve is. A large G (like in steel) means you'll only see a tiny distortion γ for a given τ. A small G (like in rubber) means even a small τ yields a noticeable angle. This directly parallels how a stiff spring vs. a soft spring behaves – G is like a spring constant for shear deformations.
- **Term-by-Term Insight:** In $\tau = G\,\gamma$:

  τ is what you solve for if a problem gives allowable shear stress and asks how much strain or angle that corresponds to, or conversely, if given an observed shear strain and needing the stress. It has the same units as pressure because it *is* a type of stress (force divided by area).

  γ (gamma) is often given in problems where you have an angular deflection. For example, if a steel rod in torsion twists 2 degrees over some length, the shear strain in radians is $2° \times \pi/180 \approx 0.035$ rad. Using $\tau = G\gamma$ with steel's G, you'd find the corresponding shear stress. Always convert to radians for calculations.

  G, the material constant, might be directly given in a problem (e.g. "modulus of rigidity of brass = X psi") or you might have to calculate it from E and ν. Because the FE Reference **exam handbook** typically lists common values of E, G, and ν for materials, you can quickly look up typical G if needed. But often, if they expect calculation, they'll provide E and ν. Knowing the formula to get G is crucial.
- **Common Misunderstandings:** One pitfall is thinking that **Poisson's ratio** itself is directly the shear strain per normal strain or something similar – that's incorrect. Poisson's ratio links lateral and longitudinal *normal* strains under axial load, whereas the shear modulus links shear stress to shear strain. They are related but not the same thing. Another misunderstanding is forgetting that shear strain is an angle (so 0.1 is actually quite a large shear strain ~5.7°, not 10% elongation but 0.1 radian distortion).

- **Exam tip – units and magnitude:** On the FE, if you're computing a shear strain and get a value like 0.0002, that means 0.0002radians (about 0.011°). That's perfectly plausible for a metal under reasonable stress; for example, $\tau = 50$ MPaand $G \approx 80$ GPagives $\gamma = \tau/G \approx 6.25 \times 10^{-4}$. If you get something like 25, that's 25radians (about 1433°!), clearly wrong. You've almost certainly mixed up units (e.g., not converting MPa to Pa) or divided by Gin the wrong units. Use sanity checks: engineering materials typically fail in shear at strains on the order of a few percent, say $\gamma \sim 0.02$, which is about 1.15°. Any *elastic* shear strain you compute should be a small fraction of that, usually less than about 0.001.

K08.T06.S02 – Transverse Shear in Beams (Shear Stress Distribution & Shear Flow)

Principle: When a beam is subjected to a **transverse shear force** (internal shear force V), the resulting shear stress is not evenly distributed over the cross-section. Unlike axial stress (which is uniform over a cross-section under pure tension/compression), **shear stress in a beam varies with the cross-section shape and position**. Key ideas include:

- **Non-uniform Distribution:** Shear stress in a bending beam is zero at the very top and bottom surfaces (where the material is free to slide) and generally maximum at or near the **neutral axis** (the centroidal axis of the cross-section). In a rectangular beam, for example, the shear stress follows a parabolic distribution, peaking at the mid-height. In an I-beam, most shear is carried by the web (center) rather than the flanges (top/bottom plates).
- **Shear Stress Formula:** The internal shear stress at a given horizontal layer of the beam is given by:

  $$\tau(x,y) = \frac{V\,Q(y)}{I\,b(y)},$$

  where V is the internal shear force at that cross-section, Q is the **first moment of area** about the neutral axis for the part of the cross-section **above (or below)** the level where you are finding τ, I is the second moment of area (moment of inertia) of the entire cross-section about the neutral axis, and b is the width of the cross-section at that layer (the thickness in the direction of the shear). This formula is derived from beam equilibrium and the assumption of linear stress distribution in bending – it essentially tells how the "shear flow" of V is shared across the section.
- **Shear Flow in Built-up Members:** In composite or built-up beams (e.g. a wooden beam made of two planks glued together, or an I-beam with a web and flange bolted), we often use **shear flow** $q = VQ/I$ to design connectors (glue, bolts, etc.). *Shear flow* has units of force per unit length (N/m or lb/in) and represents how much shear force is "flowing" along the interface between components. It's related to shear stress by $q = \tau \cdot b$ (essentially the numerator of the τ formula without dividing by thickness). For example, if two boards carry a total shear V, the glue between them must resist a shear flow q; multiplying q by a given interface length gives the shear force on that segment of glue.
- **Use in Design and Exam Problems:** FE exam problems may ask for the **maximum shear stress** in a beam (you'd typically evaluate τ at the neutral axis where Q is largest), or the shear stress at a specific location (requiring computing Q for that location). Alternatively, a question might give you a built-up beam and ask for the shear flow or the force in a fastener (which would be q times the spacing or length). Recognize that **average shear stress** V/A is not the maximum; for rectangles the max is 1.5 times the average, and for other shapes different factors apply.

Exam Handbook Search Cues (Not affiliated with or endorsed by NCEES): *VQ/Ib*, *transverse shear stress*, *shear flow q*, *first moment of area (Q)*, *neutral axis*, *built-up beam shear*.

Equation Passport: Beam Shear Stress Formula – determines **internal shear stress** at a given location in a beam's cross-section due to an internal shear force **V**. It helps allocate the shear force across the cross-section's area.

Name and Purpose: Transverse Shear Stress Formula ($\tau = \frac{VQ}{Ib}$) – Computes the shear stress at a specific horizontal slice of a beam cross-section carrying shear force V. This equation lets you find τ at any point once you know the cross-sectional geometry, revealing how the shear is distributed (useful for finding peak stresses or stress at glue lines, etc.).

Mathematical Formulation:

$$\tau(y) = \frac{V\,Q(y)}{I\,b(y)}$$

The related **shear flow** is $q(y) = \frac{V\,Q(y)}{I} = \tau(y)\,b(y)$.

Variables and Units:

- V: internal shear force at the cross-section (from your shear diagram or equilibrium), **Units:** N or kN (SI); lb or kip (US).
- $Q(y)$: first moment of area **above** (or below) the layer where τ is calculated, about the neutral axis. Computed as $A_{\text{above}} \cdot \bar{y}$ – the area above that layer times the distance of its centroid to the neutral axis. **Units:** m³ (SI) or in³ (US) (area × length).
- I: second moment of area (moment of inertia) of the entire cross-section about the neutral axis, **Units:** m^4 or in^4.
- $b(y)$: width of the cross-section at the layer where τ is being calculated. For a rectangular section, b is constant (the breadth); for an I-beam, b would be the thickness of the web at web sections (or flange thickness if computing τ in the flange area). **Units:** m or mm (SI); in (US).
- q: shear flow at that location (useful for interfaces in built-up beams), **Units:** N/m or lb/in (force per unit length). (Note: $q = VQ/I$ has the same numerator as τ but omits b, effectively "spreading" the shear force along the length of a beam interface.)

Assumptions and Scope:

- **Linear Elastic, No Shear Exceeding Yield:** The formula assumes the material's shear response is elastic and the shear stress is below the yield limit, so the distribution holds. In plastic or high-shear scenarios, distribution might change (not typical for FE exam questions).

- **Straight beams with small deflection** and **uniform material**: The cross-section doesn't warp significantly and remains plane (the derivation comes from the classic bending shear formula). It also assumes the beam cross-section is homogeneous (single material). For composite (dissimilar materials) beams, one must transform sections to an equivalent material to use this directly.
- **Applicable to symmetrical and unsymmetrical sections:** The formula works for any shape, but be careful with where the neutral axis is and calculating Q accordingly. For *closed thin-walled sections*, a different shear flow approach (using torque-like formulas) is sometimes used, but that's beyond FE scope unless specifically hinted.
- **Shear in Beams Only:** This formula is specifically for shear caused by **bending** (transverse loads on beams). Don't confuse it with shear stress due to torsion in circular shafts (which uses a different formula $\tau = Tr/J$).

Limit and Boundary Cases:

- At the very top or bottom of the cross-section, the area above that point is zero, so $Q = 0$. The formula gives $\tau = 0$. Indeed, the free surface has zero shear stress (no material above to carry shear).
- At the neutral axis (middle of a symmetric cross-section), Q is largest (for a symmetric section, the area above NA is half the area, and its centroid is at mid-height of that half). This usually gives the **maximum τ**. For example, in a rectangle of area $A = bh$, at NA: $Q = \frac{A}{2} \cdot \frac{h}{4} = \frac{bh \cdot h}{8} = \frac{bh^2}{8}$; and $I = \frac{bh^3}{12}$. Plugging in: $\tau_{\max} = \frac{V(bh^2/8)}{(bh^3/12) \cdot b} = \frac{V}{A} \cdot \frac{h^3}{8} \cdot \frac{12}{h^3} \cdot \frac{1}{b}$ (simplify carefully) yields $\tau_{\max} = \frac{3V}{2A}$. This confirms the known 1.5 factor for rectangles. We see as y moves from NA to top, Q decreases and τ drops to 0.
- If the cross-section has varying width b (like I-beam flanges vs web), note that τ can jump at the interface of flange and web because b changes abruptly. However, $q = VQ/I$ will remain continuous. For design, we typically only consider web shear (since flanges are wide but thin in the vertical direction, τ there is low).

Using vs. Sibling Equations: Use $\tau = \frac{VQ}{Ib}$ **for internal shear stress distribution in beams**. Do not use it for **axial** or **bending** stress (those use $\sigma = \frac{My}{I}$ or $\sigma = \frac{P}{A}$). Also, do not confuse *Q (first moment)* with Q as in heat (unrelated), or q with distributed load (in beam loading, q often denotes a distributed load in N/m; here q is shear flow, context will differentiate them). If the problem is about **torsional shear** in a circular shaft, use $\tau = \frac{Tr}{J}$ instead of this bending shear formula.

Common Exam Traps:

- **Forgetting to use the correct area for Q:** Q is *not* the area of the whole section or the area below the point – it must be the area *above* (or below) the level where you're finding τ, whichever portion gives the smaller segment from that point to the extreme fiber. A common mistake is to use half the area for any y – that's only correct at the neutral axis of a symmetric section. If asked at some other level, carefully take the area from that level to the top (or bottom). For instance, if finding shear stress at mid-depth of the top half of a beam, Q would be the area of the top quarter of the section (above that point) times the distance from NA to that quarter-area's centroid.
- **Mixing up b and breadth elsewhere:** Ensure b in this formula is the width *of the cross-section at that layer*. If you're dealing with an I-beam, in the web (vertical middle) b is the web thickness, not the flange width. Many mistakes occur by using the overall width of the section instead of the local thickness. If the problem specifically asks for shear stress in the web at some point, use web thickness for b.
- **Unit consistency:** The product VQ might be given in mismatched units if you're not careful (e.g. V in kips, Q computed in in³). Make sure I and Q are in the same unit system (both SI or both US Customary). If V is in kN and dimensions in mm, convert to N and mm to m appropriately for I (m^4) and Q (m³) – or convert everything to base units. The formula itself is unit-agnostic but you must be consistent within it.
- **Shear vs. Bending Formula Confusion:** Some students mix up $\tau = \frac{VQ}{Ib}$ with $\sigma = \frac{My}{I}$. Remember: *VQ/ Ib* has one more b in the denominator. A helpful memory: The shear formula has b because shear stress spreads over a width. The bending formula doesn't, because normal stress spreads over the full depth and varies linearly with y. Writing the units can also help: in τ formula, Q has an extra length unit compared to y (since Q = A·y has area*length); thus dividing by b (length) keeps the units consistent as stress.

Footnotes and Design Insights:

- *Neutral Axis and Symmetry:* For symmetric sections under symmetric loading, the neutral axis is at the geometric centroid. Shear stress is symmetric about this axis. If a section is unsymmetric (like a T-section bending about a strong axis), NA shifts and the max shear might not be at mid-depth – but the formula still applies with the actual NA and appropriate Q. The FE exam typically sticks to symmetric sections (rectangular, circular, I or box beams) unless specifically testing knowledge of NA location.
- *Shear Flow Uses:* If asked for the **force in a fastener (like a nail or rivet)** in a built-up beam, you'd compute shear flow $q = VQ/I$ at the interface of interest, then multiply by the spacing or length that one fastener "covers". For example, if two plates are connected by rivets spaced s apart along the beam, the shear force per rivet would be approximately $q \times s$.
- *Limits of Formula:* In very deep beams (high h/b ratio), shear deformation can contribute significantly to deflection (beyond bending deflection). The given formula is still valid for stress, but one should be aware that it assumes a linear strain distribution from bending – which isn't perfectly true if shear deformation is large. However, for FE exam purposes, you won't need to derive shear deflection unless using the engineering beam deflection formulas (often provided).
- *Combined Shear and Bending:* If a problem gives both bending moment M and shear V at a section and asks for "maximum stress", you might need to compute both bending stress (σ = M c / I at outer fiber) and shear stress (τ = VQ/ I b at NA for max τ) and then possibly combine

via Mohr's circle or just report whichever is relevant. Usually, bending stress will be much higher than shear stress in slender beams, except near supports where M may be small and V high.

Explanation & Analysis: The essence of the $\tau = \frac{VQ}{Ib}$ formula is that **shear stress is higher where there's more material "above it" to carry part of the shear force**. Consider a beam with a rectangular cross-section under a downward load. The internal shear V must be transmitted across the depth of the beam. Near the mid-height, there is a lot of area above that point that can help carry the shear (in an intuitive sense, the material above "drags along" the material below through shear). Near the top, there's little area above, so the shear stress there is very small – the top layers can't single-handedly carry much V since they're only connected to a small portion of the cross-section below.

To use the formula in practice on the exam:

1. **Identify the cross-sectional geometry**. Determine I (moment of inertia about NA) if not given. For common shapes like rectangles or circles, I may be given or easy to compute ($I_{\text{rect}} = \frac{bh^3}{12}$, $I_{\text{circle}} = \frac{\pi d^4}{64}$, etc.). Make sure you know the neutral axis location (center for symmetric shapes).
2. **Determine where you need τ.** Is it maximum τ (likely at NA for a symmetric section)? Or at a specific distance from top? The problem might specify a point or just ask generally. If maximum, you usually take y = 0 (NA). If a specific point, note its distance from top or bottom.
3. **Calculate Q for that location.** This is usually the trickiest part. Q = area *above* that level × distance from NA to that area's centroid. For maximum τ at NA in a symmetric section, "area above NA" is half the cross-sectional area, and the centroid of that half-area is at a distance $h/4$ from the NA (for full height h). For other points, you might break the area above into a simple shape. *Example:* Suppose a T-beam where you want τ at the flange-web junction. Area above that junction is the flange area; its centroid distance to NA needs calculation. Draw a little sketch if needed to get these right on exam – it's worth the few seconds.
4. **Plug into $\tau = VQ/(Ib)$.** Use the correct b for that layer (flange thickness vs web thickness, etc.). Compute the value. If the problem expects a numeric answer, mind units (convert V into consistent units with I). If it's a conceptual question (like "where is τ max?"), you'd answer "at the neutral axis in the web" or similar.
5. **Interpret the result.** Check if it makes sense: Is τ max smaller than the material's shear yield? Is it logical that, say, τ near the top was lower than τ at mid-depth? In exam problems, they may ask qualitative things like comparing shear stress at two different points – you can reason using the formula without full calc by recognizing that a point with more area above it (larger Q) yields higher τ.

   A practical sanity check: compute the cross-sectional average shear V/Aas a baseline. Your maximum shear stress $\tau_{\max}$should be a known factor times that for the given shape (e.g., 1.5 ×for a rectangle, $\approx \frac{4}{3}$ ×for a circle, etc.). If your computed $\tau_{\max}$is wildly different, re-check the math.

   For instance, if $V = 10$ kNon a rectangular 10×20 cmsection (area $A = 200\ \text{cm}^2 = 2 \times 10^{-2}\ \text{m}^2$), the average shear is $\tau_{\text{avg}} = \frac{V}{A} = \frac{10^4\ \text{N}}{2\times10^{-2}\ \text{m}^2} = 5 \times 10^5\ \text{Pa} = 500\ \text{kPa}$. We expect $\tau_{\max} \approx 750$ kPa(i.e., 1.5×500 kPa). Using the formula for a rectangular cross-section with width $b$and height h, $I = \frac{bh^3}{12} = \frac{0.1\,(0.2)^3}{12} \approx 6.67 \times 10^{-5}\ \text{m}^4$. At the neutral axis (NA), $Q = \bar{A}\,\bar{y} = \frac{A}{2} \cdot \frac{h}{4} = 0.01\ \text{m}^2 \cdot 0.05\ \text{m} = 5 \times 10^{-4}\ \text{m}^3$, and $b$at the NA is the full width, $b = 0.1$ m. Thus, $\tau = \frac{VQ}{Ib} = \frac{10^4 \cdot 5\times10^{-4}}{6.67\times10^{-5}\cdot 0.1} \approx 0.75 \times 10^6\ \text{Pa} = 750\ \text{kPa}$. This matches the expected scale. If we had obtained 75 MPaor 75 kPa, that would flag an error (a factor of about 100off from the expected value). Such intuition can save you from mis-keying something on the calculator.

Finally, **shear flow** $q = VQ/I$ deserves a note: it's essentially what you'd use to design connectors in composite beams. If two halves of a beam must be glued, the glue at a horizontal plane must carry a shear **force** equal to the shear flow times the length of that plane. So if $q = 2000$ N/m at an interface, every meter of that interface carries 2000 N of shear force. If connectors (like nails) are spaced, multiply q by the spacing to get force per connector. The FE exam could directly ask for shear flow, but more often it might give a shear force and ask something like "what is the shear stress in the web?" or "what is the shear force carried by the glue per unit length?" – both tie back to this formula. Recognizing q in the latter phrasing is crucial.

K08.T06.S03 – Sign Conventions for Internal Shear Forces in Beams

Principle: A **sign convention** is a consistent way to denote the positive or negative direction of internal forces and moments. For shear forces in beams, the standard convention used (including on the FE exam) is usually the *right-hand rule convention for beam sections*. In simple terms:

- **Positive Shear Definition:** An internal shear force is defined as **positive** if it causes a clockwise rotation of the beam segment (i.e. the beam tends to bend into a *smile* shape, concave up). Equivalently, if you make an imaginary cut through the beam, a positive shear force exists when the portion of the beam on the **right** of the cut is forced *downward* relative to the portion on the left. This corresponds to the left side of the cut experiencing an upward shear force.
- **Negative Shear:** Conversely, a shear force that would rotate the beam segment counterclockwise (bending the beam concave down, like a frown) is taken as negative. That means if the right side of the cut moves *upward* relative to the left side, the shear is negative (left side of the cut has a downward internal force).
- **Bending Moment Tie-In:** This shear sign convention is paired with the bending moment sign convention where a **positive bending moment** produces concave-up bending (tension at the bottom, compression at top). Positive shear, as defined above, will typically accompany regions where bending moment is increasing in the positive sense. In fact, when you plot shear and moment diagrams: a positive distributed load yields a negative slope on the shear diagram, and a positive shear yields a positive slope on the moment diagram (with the above sign conventions).

- **Why It Matters:** Using consistent sign conventions is essential for writing equilibrium equations, drawing internal force diagrams, and interpreting results. On the FE exam, you might need to identify whether a shear diagram is drawn according to the conventional sign or answer a question about the effect of loads on shear/moment signs. Knowing that "positive shear makes the right side go down" helps you quickly check if a diagram segment should be positive or negative given a loading scenario.

Exam Handbook Search Cues (Not affiliated with or endorsed by NCEES): *positive shear*, *shear sign convention*, *beam internal forces*, *shear and moment diagrams*.

Definition Passport: Positive Shear (Beam Sign Convention)

- **Plain-language Definition:** In beam analysis, **positive internal shear** is defined such that cutting the beam and examining the two faces, the left face of the cut has an upward force and the right face has an equal downward force. This means the right segment moves downward relative to the left – a quick way to remember it is that the right side of the cut "drops down" for positive shear. This convention results in a **clockwise moment** on the cut section and aligns with "sagging" (concave-up) bending as positive.
- **Where it Matters (Exam Impact):** This sign convention is used when drawing **shear force diagrams** and applying the relationship $\frac{dM}{dx} = V$. On the FE Mechanical exam, you may be given a shear diagram and need to interpret the loading or moments, or vice versa. If you know the convention, you can tell, for example, that a positive shear value at a section will cause the moment diagram to slope upward to the right of that section. Many exam problems in mechanics of materials and statics involve matching the correct shear/moment diagram to a loading scenario – using the wrong sign convention could lead to misidentifying the correct diagram.
- **Common Pitfall:** The biggest source of confusion is that different textbooks sometimes use opposite conventions (some define downward shear on the right as **negative** instead). NCEES is likely using the classic engineering convention described here (also known as the *internal sign convention with positive shear causing concave up bending*). You must stick to one convention throughout a problem. A student might mix conventions mid-solution – for example, assume one sign for cutting the left section but draw the shear diagram as if using the opposite sign rule. This will cause errors that are hard to trace. Always define your sign convention at the start and be consistent. If the exam problem statement or diagram indicates a certain sign usage (e.g., it labels a positive V upward on the left side of a cut), follow that.
- **Micro-check:** *True or False:* "If a beam's internal shear force at a section is positive (by the usual convention), the internal moment just to the right of that section will be **lower** than just to the left." **Answer:** FALSE. Because dM/dx = V, a positive shear means moment increases as x increases. Therefore, the moment just to the right is higher than just to the left.

(The micro-check above is testing understanding of shear-moment relationship: Given our convention, a positive shear (up on left, down on right) typically corresponds to moment that is increasing *to the right. Actually, by equilibrium $dM/dx = -q$ (load) and $dV/dx = -w$. With our convention, $dM/dx = V$ if we consider sign of V differently. It's easy to confuse. Let's clarify further down rather than the micro-check if needed, or adjust micro-check to simpler concept.)*

Correction to Micro-check: Let's use a simpler check: *A positive shear force at a cut implies the left cut face pushes upward on the right face.* So question: "If you cut a beam and find the left face pushes upward on the right piece, is that positive shear?" (Yes, that is exactly positive shear by definition.) This reinforces the concept.

Explanation & Analysis: The sign convention for internal shear isn't about physics as much as about consistency in problem solving. By choosing a standard, we can predict how loads, shear, and moments relate:

- **Beam Segments and Cuts:** Envision a simply supported beam with a downward concentrated load in the middle. The left support reaction is upward. If you cut the beam somewhere between the left support and the load, the left segment has an upward reaction holding it up, and the right segment with the load tends to drop. The internal shear at that cut transmits the force: the left face of the cut will exert an upward force on the right face (to hold the right side up). According to our convention, that's a **positive shear** at that section. The shear diagram from x=0 to mid-span would be drawn as a positive constant (equal to that reaction). At the mid-span where the load is, shear will drop (likely to a negative value on the other side if the right support is taking the rest). If one didn't follow the sign convention, one might draw it inverted, getting the moment diagram wrong. So remembering **"left face up, right face down = positive V"** keeps everything straight.
- **Shear-Moment Relationship:** With this convention, a positive shear value means the bending moment is increasing in the positive sense as you move right. In mathematical terms (for those curious), if $M(x)$ is the bending moment with positive sagging, then $\frac{dM}{dx} = V(x)$ with this sign setup. For example, under a uniform downward load (w positive downward), the shear is negative (since the right side of any cut is being pushed up by the left side reaction to hold the distributed load – opposite of our positive definition), and correspondingly the bending moment curve slopes downward to the right (reaching maximum moment at the center then decreasing). This consistency is why we adopt the sign rules as stated: they make the calculus relationships straightforward (**dM/dx = V, dV/dx = -w** when using the convention of upward forces positive on the left cut face and downward distributed load as negative *w*).
- **Pitfalls in Practice:** A common exam scenario is matching a load diagram to shear and moment diagrams. If you forget the convention, you might mistakenly think an upward triangular load would produce an upward (positive) triangular shear diagram – but if the load is up, that's actually a support or something, and likely the shear diagram should be drawn negative (since upward reaction causes positive shear in left section? Actually, careful: an upward reaction at left end is an upward force on the left face from the support – but the shear sign convention deals with internal cuts, not external loads. Perhaps simpler: A downward distributed load yields a linearly decreasing shear from positive to negative; if one

thought upward was positive shear, they'd misinterpret sign). To avoid confusion: always anchor yourself by thinking of a cut. Take a small segment of beam and draw forces: require equilibrium. If the left portion has an upward force on the right portion, you have positive V. Do this at a known scenario (like near a support) to set the sign for the diagram.

- **Different Conventions:** If you learned a different sign convention (some sources define positive shear as left side down, right side up – essentially the opposite), you can still solve problems correctly as long as you stay consistent. But mixing conventions with the exam reference or given diagram will result in errors. It's safest to use the convention likely assumed by NCEES: positive shear makes a beam want to smile (concave up). This aligns with the common sign for bending (positive bending makes a smile).
- **Sign of Shear Stress vs. Shear Force:** Note that we've been talking about internal shear *force* sign. Shear **stress** (τ) at a point can also be considered positive or negative depending on orientation (for Mohr's circle or stress transformation, a sign convention is used where, typically, a shear stress that tends to rotate an element clockwise is taken as positive). That's a separate convention in stress analysis. In most beam problems, you won't really attach a "+" or "–" to τ in calculations; you'll just compute a magnitude and maybe indicate direction on the cross-section. The internal shear force sign, however, is critical for diagramming and superposition. So, focus on mastering the shear **force** sign convention for beam diagrams.

In summary, remember this handy rule for the FE Mechanical exam: **Positive shear force = left segment pushes up on right segment.** Pair that with **positive moment = beam bending concave up**. These will help you quickly interpret and draw shear/moment diagrams correctly. If you ever get confused, draw a quick free-body of a cut section and solve for equilibrium – the sign on the shear you solve for will tell you which way you assumed was positive. Stick to the convention and you'll avoid sign-flipping errors that can derail an otherwise correct solution.

Topic 07 - Stress and Strain Caused by Temperature Changes

Topic Overview: This topic deals with how structural materials deform and develop stress when their temperature changes. Thermal expansion can elongate or shorten components, which is harmless if they are free to move, but can induce significant internal **stress** if expansion is restrained. On the FE Mechanical Exam, you'll encounter questions asking for **thermal elongation** (change in length) of a member given a temperature change, the **thermal stress** induced in a fully or partially constrained member, and how to include thermal strains in structural analysis (especially in **statically indeterminate** cases and deflection calculations). Mastering this topic helps you avoid common pitfalls on exam day, like missing a thermal strain term in a deformation problem or confusing units for the coefficient of expansion. In practical terms, understanding thermal stresses is crucial – it explains why bridges have expansion joints and why machines need clearance for temperature swings (preventing **thermal binding** or cracking).

Exam relevance: Expect 1–2 questions combining this topic with mechanics fundamentals. Typical problem scenarios include a metal rod that heats up or cools down (compute the change in length or stress), a composite structure (different materials expanding differently), or a truss/beam where a temperature change causes extra deflection or internal forces. The key is recognizing when to apply the thermal expansion formula and when to superimpose thermal effects with mechanical loads. Always remember to check if the member is free (no stress) or restrained (thermal stress present) – that's the deciding factor in the solution approach.

K08.T07.S01 – Free Thermal Expansion (Unrestrained)

Principle introduction: When a material's temperature rises, it **expands** in length; when the temperature falls, it **contracts**. If nothing restrains this change (no fixed supports or external forces holding it back), the material will change length without developing any stress. Key points to remember:

- **Linear expansion:** The change in length ΔL is directly proportional to the original length L and to the temperature change ΔT. A larger initial length or a bigger temperature increase produces a larger absolute expansion.
- **Coefficient of thermal expansion (α):** This material property (often given in units like 1/°C or 1/°F) is the proportionality constant. It represents how much *strain* (change in length per unit length) a material undergoes per degree of temperature change. Higher α means the material is more sensitive to temperature (expands/contracts more for the same ΔT).
- **No stress if unrestrained:** In free expansion, the material simply changes length and "relaxes" into its new size. There are **no internal forces** needed to cause this deformation, so **no thermal stress** is induced. The material experiences a thermal *strain* of magnitude α·ΔT, but since nothing is pushing or pulling on it to prevent this strain, stress = 0.
- **Reversible and uniform:** Thermal expansion is usually uniform along the object (assuming even heating). If the temperature returns to the original value, the material returns to its original length (no permanent deformation as long as we stayed in the elastic range). This linear formula is a good approximation for moderate temperature changes within the elastic regime of the material.

Equation Passport – Linear Thermal Expansion – computes the change in length (deformation) of a material due to a uniform temperature change (no external restraint or load involved):

Professional equation (1D linear expansion):

$$\Delta L = \alpha L \Delta T$$

Variables and units:

- ΔL – change in length of the object (m, or in any length unit consistent with L)
- α – coefficient of linear thermal expansion (1/K or 1/°C in SI; likewise 1/°F in US units [^2])
- L – original length of the object before the temperature change (m)
- ΔT – change in temperature (K or $°C$; a temperature difference is the same number in Kelvin and Celsius)

Assumptions and scope:

- The temperature change is uniform throughout the material (the entire length experiences the same ΔT).
- Material properties like α remain constant over the temperature range (valid for small-to-moderate temperature changes; extreme ΔT can make α vary slightly, but that's beyond FE exam scope).
- The material is homogeneous and isotropic (expands the same in all directions). We're considering *unrestrained linear expansion* in one dimension here.
- *No external stress or constraints: The formula assumes the member is free to expand or contract. Under this condition, expansion causes strain* $\epsilon_{thermal} = \alpha \Delta T$ *but* $\sigma = 0$ *(no stress) because there's no opposing force.*

- **Limit tests (sanity checks):** If $\Delta T = 0$, then $\Delta L = 0$(no temperature change, no length change—as expected). If the material had $\alpha = 0$(hypothetically, like an "invar" alloy engineered to have near-zero expansion), then $\Delta L = 0$for any ΔT—it wouldn't expand at all. If the bar's original length $L$is zero, $\Delta L$is obviously zero (no material, nothing to expand). All these make sense. For a typical metal (α on the order of $10^{-5}\ °C^{-1}$), a moderate ΔT(say 50 °C) and a meter-long rod give a few tenths of a millimeter of expansion—a small but noticeable change.

- **Use vs. sibling equations:** Use this equation to find thermal deformation directly when no restraints are present. It should be used instead of any structural stress formulas when you know the member can freely change length (e.g., a long pipe sliding in supports, or a gap is present to allow expansion). By contrast, if the member is restrained, you should use the thermal stress equation (which combines this free expansion with Hooke's law)—see subtopic K08.T07.S02. In summary: free ⇒use ΔL = αLΔT; fixed ⇒consider stress instead.

Common exam traps:

- **Mixing up units:** Make sure ΔT and α are in compatible units. For example, if α is given per $^\circ$C, then use ΔT in $^\circ$C (a temperature *difference* in K has the same magnitude as in $^\circ$C). If you're working in US Customary units, α might be given per $^\circ$F; be careful: a 1°C change corresponds to a 1.8°F change. Always use a ΔT that matches the units of α.
- **Using the wrong length:** L is the initial length at the original temperature. Don't mistakenly use a different length or mix up ΔL and L. A common slip is to plug in ΔL for L or vice versa; remember ΔL is what we're calculating (or sometimes given), not an input.
- **Forgetting it's *strain***: α is essentially strain per degree. Sometimes students confuse thermal expansion coefficient with other thermal properties (like thermal conductivity or diffusivity) because of the word "thermal." On the exam, if you see units of 1/°C or 1/°F, that's a dead giveaway it's a coefficient of expansion. Use it for length change, not in heat transfer formulas.
- **Rushing to stress:** If a problem says a member is "unconstrained" or asks "how much longer does it get?", don't waste time computing stress – there isn't any in free expansion. The answer is just the change in length from the formula above. Conversely, if they want stress, realize there *must* be some restraint (see next subtopic).

Exam Handbook Search Cues (Not affiliated with or endorsed by NCEES): thermal deformation, coefficient of expansion, αLΔT, ΔL (temperature). (In the exam reference handbook, look for a "Thermal Deformations" entry or the formula $\delta_t = \alpha L(T - T_0)$, which is the same as above. The handbook lists typical α values for materials in a table as well, useful for context.)

[^1]: Preparation Tip: Always double-check that the question provides or assumes a value for α (coefficient of thermal expansion) when needed. If not given explicitly, it might be hidden in a table of material properties or stated in words (e.g. "steel's expansion coefficient is approximately 12×10^{-6} per °C"). The FE Exam Handbook includes a table of α for common materials (steel ~11.7×10^{-6}/°C, aluminum ~23×10^{-6}/°C, etc.), but you should recognize reasonable magnitudes; metals are on the order of 10^{-5} 1/°C.

[^2]: Unit nuance: 1 Kelvin change = 1°C change in magnitude. So whether α is given per K or per °C, you use the same numeric value for ΔT in degrees Celsius. However, 1 $^\circ F$ is a smaller interval; if α is per °F, it will be a different number, approximately

$$\alpha_{\text{per }^\circ\text{F}} = \frac{\alpha_{\text{per }^\circ\text{C}}}{1.8}$$

Pay attention to the units to avoid a 1.8× error.

K08.T07.S02 – Thermal Stress from Restrained Expansion (Fully Fixed)

Principle introduction: If a material tries to expand or contract with temperature change but **cannot** (due to rigid constraints or supports), it will **build up internal stress**. Essentially, the structure fights itself: the material's thermal strain is "locked in," and Hooke's law (spring behavior of the material) kicks in to oppose the deformation. Important highlights:

- **Restrained expansion = induced stress:** When expansion is prevented, the would-be thermal deformation turns into an internal **force**. Think of the material as a strong spring: heating wants to stretch the spring by αΔT * L, but if the spring is anchored at both ends, it instead develops a force as it pushes against the immovable supports.
- **Thermal stress formula:** For a fully fixed member (no expansion at all), the thermal stress is $\sigma_{\text{thermal}} = E\,\alpha\,\Delta T$. This comes from Hooke's law ($\sigma = E\epsilon$) using the "would-be" free strain $\epsilon_{\text{thermal}} = \alpha\Delta T$. Since the actual strain is zero (no length change), the material must be compressed by an amount equal to the free expansion, which generates $\sigma = E(0 - \alpha\Delta T) = -E\alpha\Delta T$. In magnitude, $|\sigma| = E\alpha\Delta T$. A positive ΔT (heating) produces compressive stress (the material pushes outwards against the restraints), whereas a negative ΔT (cooling) produces tensile stress (the material tries to contract and the anchors pull it taut). Sign conventions aside, use the magnitude $E\alpha\Delta T$ and then judge whether it's tension or compression from the situation.
- **No deformation occurs (ε = 0):** In the fully restrained scenario, the length of the member doesn't change at all despite the temperature change. All the thermal tendency is absorbed as elastic strain energy (stress). If you ever compute a thermal stress and still add a thermal deformation somewhere, stop – in a fully fixed setup, ΔL is zero (that's the definition of "restrained"). This is a common check: either the member expands (ΔL) or it's restrained and builds stress, or partially both. For the fully fixed case, all expansion is negated by the structure.
- **Material response and limits:** The linear formula $\sigma = E\alpha\Delta T$ assumes the material stays in the elastic range. If the calculated thermal stress is extremely high (e.g. beyond yield strength), in reality the material would yield or buckle, relieving some stress. The FE exam usually avoids such cases or implies everything remains elastic. Just be aware that thermal stresses can be very large – for instance, a ΔT of 50°C in steel (with $E \approx 200$ GPa, $\alpha \approx 12 \times 10^{-6}$) gives $\sigma \approx 200e912e - 650 \approx 120$ MPa, which is a substantial stress (over 17,000 psi). Engineers often design expansion joints or slots to prevent these high stresses.

Equation Passport – Thermal Stress (Fully Restrained) – computes the internal normal stress induced by a uniform temperature change when expansion is completely prevented:

Professional equation (axially restrained member):

$$\sigma_{\text{thermal}} = E\,\alpha\,\Delta T$$

Variables and units:

- σ_{thermal} – thermal stress developed in the material (Pa or psi). This can be a tensile or compressive stress; by convention, a positive value from $E\alpha\Delta T$ corresponds to tensile stress if ΔT is negative (cooling) and compressive if ΔT is positive (heating) – essentially $\sigma = E(\Delta\epsilon)$ with $\Delta\epsilon$ being negative for heating (because actual $\epsilon - \alpha\Delta T = 0 - \alpha\Delta T = -\alpha\Delta T$).
- E – Young's modulus of the material (Pa or psi), the material's stiffness in tension/compression.
- α – coefficient of linear thermal expansion (1/K or 1/°C in SI; 1/°F in US units), same as in K08.T07.S01.

- ΔT – change in temperature (K or °C). Important: Use the algebraic temperature change: $T_{\text{final}} - T_{\text{initial}}$. For example, going from 20°C to 60°C, $\Delta T = +40°C$ (heat up); from 60°C down to 20°C, $\Delta T = -40°C$ (cool down).

Assumptions and scope:

- The member is fully restrained axially – *no* change in length. This typically means both ends are anchored to something much stiffer (like massive walls or fixed supports) that do not move. Partial restraint or flexible supports will reduce the stress (see variations below).
- Uniform temperature change across the member. If one part of the member is hotter than another (temperature gradient), it can cause bending and complex stress distribution – that's beyond the basic formula and not usually tested in FE (it's more advanced, involving thermal bending stresses).
- Linear elastic behavior (no yielding). We assume the induced stress is below the material's yield strength so that Hooke's law holds throughout. The FE exam won't expect you to handle plastic deformation of thermal stress unless explicitly stated.
- No external mechanical loads considered simultaneously in this formula (we handle combined loading in subtopic S03). This formula just addresses the stress due *solely* to thermal expansion being restrained. If other loads are present, superposition applies (and you must combine stresses appropriately).

Limit tests: If $\Delta T = 0$, then $\sigma_{\text{thermal}} = 0$ (no temperature change, no stress – trivial). If the restraint is removed (conceptually $E \to 0$ or supports offer no resistance), $E\alpha\Delta T$ would tend to 0 – meaning no stress, which checks out with the free expansion case. If $\alpha = 0$, $\sigma = 0$ (a zero-expansion material doesn't care about temperature change). If ΔT is positive (heating up) and the rod is fixed, σ comes out positive in this formula, but remember that means compressive stress in the rod (engineers often take compressive stress as negative by sign convention [^3]; the formula gives magnitude here). If $\Delta T \to$ extremely large, σ grows linearly without bound in theory – but in reality the material would yield or the supports would deform long before infinite stress, so our linear model would break down.

Use vs. sibling equations: Use this thermal stress equation instead of the free expansion equation when you know the member cannot change length. It converts a temperature change directly into a stress via the material's stiffness. If the problem involves both a restraint and some actual deformation, or partial restraint, you might need a more general approach (see K08.T07.S03 for combining thermal strain with mechanical strain). Also, compare with the basic Hooke's law $\sigma = E\epsilon$: here the "effective strain" causing stress is the prevented thermal strain ($\epsilon_{\text{prevented}} = \alpha\Delta T$). Use this formula for cases like "both ends fixed" or "expansion completely prevented." If the member is free (one end open), don't use this – there's no thermal stress then, use ΔL formula instead. If partially restrained or combined with loads, use superposition (coming next).

Common exam traps:

- **Forgetting the sign or nature of stress:** The formula $E\alpha\Delta T$ gives you a number, but you must interpret it. If the rod was heated (ΔT > 0) under full restraint, the rod is in compression (it's trying to get longer but can't, so it's squished). If cooled (ΔT < 0), the rod is in tension. Many exam problems will explicitly ask "compressive or tensile?" or will imply it (e.g. "will the rod buckle or snap?"). Always state the proper type of stress, not just the magnitude.
- **Mismatch of units for E and α:** Make sure E and α are in compatible unit systems. For instance, if E is in GPa and α in 1/°C, ΔT should be in °C, yielding σ in GPa. If you use E in psi and α in per °C, you'll mix SI and US units – don't do that. Convert one or the other. It's safest to convert everything to SI in your calculation (or everything to USCS) rather than mix.
- **Partial restraint vs full restraint:** Sometimes a problem might not restrain the member 100%. For example, "one end of the rod is attached to a spring" or "there's a small gap before the rod touches the wall." In those cases, do not apply $\sigma = E\alpha\Delta T$ blindly for the full ΔT. Only the portion of expansion that is restrained contributes to stress. (See variations below for guidance.) A common trick: a gap of size δ means the rod expands freely for that amount, and only any expansion beyond δ is restrained and causes stress. So if $\alpha L\Delta T > \delta$, subtract the gap and compute stress from the remaining ΔT effectively. If $\alpha L\Delta T \leq \delta$, the rod never touches the wall – it expands freely and $\sigma = 0$.
- **Thermal strain vs mechanical strain confusion:** Remember that thermal strain $\epsilon_{\text{thermal}} = \alpha\Delta T$ is not a stress by itself; it's what would happen strain-wise. The stress comes from preventing that strain. If a problem gives you $\alpha\Delta T$ and also a mechanical strain or load, keep them separate until you combine properly (via superposition). Don't add a thermal strain to a mechanical stress or vice versa without converting through Hooke's law where appropriate.

Variations and special cases:

- Partial restraint: If a structure isn't fully rigid, the thermal stress will be less. A common approach is to treat the restraint as a spring. For example, if one end of the rod is fixed and the other end is attached to a spring (stiffness k), heating the rod will compress the spring some and expand the rod some. You can solve such problems by setting up equilibrium of forces and compatibility of deflections (the rod's free expansion is split between actual expansion and spring compression). While the FE exam might not require solving a spring-rod system algebraically, conceptually remember: more flexibility = less stress. In the extreme of a very soft spring, the rod expands almost freely (tiny stress); in the extreme of a very stiff spring, it approaches the fully fixed case ($\sigma \approx E\alpha\Delta T$).

- Gaps and clearances: As mentioned, an initial gap allows some free expansion. For instance, a rod in a slot with a 1 mm clearance on each end can heat up enough to expand 2 mm with no stress; beyond that, it starts pressing on the slot. These problems are solved by first seeing if $\alpha L\Delta T$ is larger than the total gap. If not, answer: no stress (and maybe how much gap remains). If yes, then subtract gap and use $E\alpha\Delta T_{\text{excess}}$ for stress (where ΔT_{excess} is the portion of temperature change that exceeded what the gap could accommodate).

- Different materials (composite systems): If two different materials are restrained together (e.g., a steel bar and an aluminum bar glued side by side, or a bimetallic strip), a temperature change will induce stress because their α values differ. The one that wants to expand more will be partially restrained by the other. This goes

beyond a single $\sigma = E\alpha\Delta T$ formula – you have to enforce that they remain attached (so their overall deformation is the same) and solve for stresses in each material. The qualitative result is that the material with higher α tends to be put into compression relative to the other, and the lower α material into tension, until their expansions match[^4]. Such calculations might appear in advanced questions, but if so, they'll usually give guidance or expect you to set up equilibrium of forces and compatibility of strains. For the FE exam, the key is recognizing that differential expansion in a constrained composite leads to internal stress (and often bending, like the classic thermostat bimetal strip that curves when heated). If time is short, remember: same formula concept but do it for each material and relate their forces via equilibrium.

Exam Handbook Search Cues (Not affiliated with or endorsed by NCEES): thermal stress, ε = αΔT, Hooke's law, Young's modulus. (The exam handbook doesn't explicitly list "thermal stress" formula, but it gives $\delta_t = \alpha L\Delta T$ and Hooke's law $\sigma = E\epsilon$. Combining those yields $\sigma = E\alpha\Delta T$ if ϵ is zero. Searching for "thermal deformation" and "modulus of elasticity" in the handbook can help confirm the pieces you need.)

[^3]: Sign Convention: In most mechanics contexts, tensile stress is treated as positive and compressive as negative (especially in formulas like $\sigma = E(\epsilon - \alpha\Delta T)$ in the next section). In this subtopic's equation we gave the magnitude for simplicity. If you use sign convention strictly: $\sigma = E\alpha\Delta T$ corresponds to a negative stress when $\Delta T > 0$ (compression) because the actual formula would be $\sigma = E(0 - \alpha\Delta T)$. Be prepared on the exam to identify the stress type in words if not explicitly asked for a sign. It's safer to state "120 MPa compressive" than to just put "-120 MPa" without context.

[^4]: In a composite (say steel and aluminum restrained together), you'd set up something like: $\sigma_{steel}/E_{steel} + \alpha_{steel}\Delta T = \sigma_{alum}/E_{alum} + \alpha_{alum}\Delta T$ (they undergo the same total strain) along with equilibrium (force in steel = force in aluminum for a two-bar setup). Solving those yields each σ. While deriving this is likely beyond FE requirements, understanding that differing α causes internal stress is important.

K08.T07.S03 – Thermal Strain in Combined Loading (Statically Indeterminate Scenarios)

Principle introduction: In many real-world cases, a member experiences mechanical loads (forces, moments) and temperature changes at the same time. The total deformation of the member is then influenced by both effects. The fundamental principle is superposition of strains: total strain = mechanical strain + thermal strain, in the absence of other effects. However, in a statically indeterminate structure (where supports or multiple members impose constraints), you can't simply let the thermal strain occur independently – it will interact with the structure's constraints, altering the force distribution.

Key ideas:

- **Total strain formula:** For a given member, you can write:

$$\epsilon_{\text{total}} = \epsilon_{\text{mechanical}} + \epsilon_{\text{thermal}}$$

In an axial member, $\epsilon_{\text{mechanical}} = \frac{\sigma_{\text{mech}}}{E}$ (from a load $\sigma = P/A$) and $\epsilon_{\text{thermal}} = \alpha\Delta T$. So this expands to $\epsilon_{\text{total}} = \frac{\sigma_{\text{mech}}}{E} + \alpha\Delta T$. This is essentially combining Hooke's law with thermal expansion. It means the material's change in length comes from both the force pulling/pushing it and the temperature changing it. If the member is free, ϵ_{total} happens and σ_{mech} is just whatever external load causes. If the member is constrained, ϵ_{total} might be forced to some value (like zero, or a certain compatibility value), and that will determine σ_{mech} (or reaction forces).

- **Statically indeterminate structures**: These are cases where supports or multiple members impose additional constraints beyond basic equilibrium (more unknown forces than independent equilibrium equations). A classic example: a rod pinned between two walls (two supports means it's redundant – this we saw as "fully restrained expansion"). Another example: two parallel rods (or different materials) sharing a load or a temperature change – the load/expansion distributes between them. In such cases, you must use a compatibility condition in addition to equilibrium: the deformation of one part equals the deformation of another, or some total deflection is zero, etc., including thermal effects. Thermal strains must be included in those compatibility equations. For instance, if a rigid bar is supported by two rods and one rod gets hotter, it will try to elongate – compatibility demands the bar remain straight, so the hotter rod's expansion will push the bar, transferring load to the other rod. You'd solve by writing that net deformation of the system equals zero (or some known value), plugging in ΔL expressions that include both PL/AE and $\alpha\Delta TL$ for each member.

- **Effect on internal forces**: A temperature change in an indeterminate structure can induce internal forces even without external load. The structure's extra support prevents free expansion, so "thermal forces" arise to enforce compatibility. These forces often counteract or add to mechanically applied forces. For example, cooling a fixed-fixed rod will induce tension that might partially cancel an existing compressive load or add to an existing tensile load.

- **Solution approach – force method or superposition**: A reliable method is to imagine the thermal effect separately and then combine it with mechanical effects:

1. Free thermal expansion step: Pretend the structure could expand freely from temperature change (no stress). Calculate the free expansion $\Delta L_{\text{free}} = \alpha L\Delta T$ for each member (or the free rotation, etc., if dealing with beams and thermal curvature – usually we stick to axial).

2. Apply constraints (compatibility) step: Now "turn on" the constraints. Ask: what extra forces/reactions are needed to counteract those free expansions and make the deformations compatible with the supports? For a simple rod between fixed ends, this means applying a force sufficient to compress the rod back to its original length. For a more complex structure, it might mean applying a set of internal forces such that the net deformation at a certain point is zero or equal for all members.

3. Superpose mechanical loads: If external loads are also present, consider those separately as well (compute deformations from just the external loads, and from just the thermal, and add if the system is linear). The net effect is the sum of mechanical deformation + thermal deformation = total deformation (which might be zero if supports prevent movement).

This process is essentially the **force method** in structural analysis: treat the redundant reaction as unknown, write that the total deformation (mechanical + thermal) at that support is zero, solve for the reaction. The FE exam might not require you to write the

full equations for a complex system, but you should conceptually understand how to combine these effects.

Equation Passport – Combined Stress/Strain with Thermal – a general relationship for a member experiencing both mechanical stress and a temperature change:

- **Professional equation (axial member combining Hooke's law and thermal strain):**

$$\sigma = E(\epsilon_{\text{total}} - \alpha\,\Delta T)$$

This is a rearranged form of $\epsilon_{\text{total}} = \sigma/E + \alpha\Delta T$. It says: the stress in a member is determined by how much less strain it has compared to the free thermal strain. For example, if a member's total strain is zero (fully fixed ends, $\epsilon_{\text{total}} = 0$) but $\alpha\Delta T$ is positive (it wants to expand), then $\sigma = E(0 - \alpha\Delta T) = -E\alpha\Delta T$ (compressive stress). If the member actually elongated more than αΔT (maybe an external load stretched it on top of heating), then $\epsilon_{\text{total}} > \alpha\Delta T$ and the term in parentheses is positive, giving tensile stress.

Variables and units:

- σ – actual stress in the member (Pa or psi), considering both load and thermal effects.
- ϵ_{total} – the actual total strain of the member (dimensionless). This might be constrained by supports or geometry of the structure. It equals the actual change in length divided by original length ($\Delta L_{\text{actual}}/L$).
- α – coefficient of thermal expansion (1/°C, 1/K, etc.).
- ΔT – temperature change of the member.
- E – Young's modulus of the material.
- *(Sometimes it's useful to break ϵ_{total} into parts: $\epsilon_{\text{total}} = \epsilon_{\text{load}} + \epsilon_{\text{support}}$. For instance, in a fixed–fixed rod with an external load P applied, the rod would elongate some amount if free ($\epsilon_{load} = P/(AE)$), but the fixed supports might not allow the full elongation – they'll provide a reaction force. In that case, ϵ_{total} might be zero, and the difference between $P/(AE)$ and $\alpha\Delta T$ manifests as a change in internal stress.)*

Assumptions:

- Linear elasticity and uniform temperature change, as before.
- The formula is one-dimensional (axial). For multi-axial states (like a plate expanding in 2D), thermal strains add in each direction similarly: e.g. $\epsilon_x = \frac{\sigma_x}{E} - \frac{\nu\sigma_y}{E} + \alpha\Delta T$ in plane stress with thermal, as given by more general formulas (the FE handbook has those for reference). But for exam purposes, most thermal stress questions are 1D or symmetric cases.
- ϵ_{total} must be known or related via compatibility. Often in an indeterminate problem, you set ϵ_{total} according to a constraint (like zero net expansion or equal expansions). Then use this formula to solve for σ (or a reaction force) as the unknown. This is exactly what the force method does.

- **Use vs. alternative forms:** This combined equation is most useful when you have a condition on the total strain or deformation. If the structure dictates a certain ϵ_{total} (like zero, or some fraction of free expansion), plug it in to get σ. It's essentially a generalized Hooke's law including thermal strain offset. If you're directly computing change in length, you might prefer to use the strain form: $\epsilon_{\text{total}} = \sigma/E + \alpha\Delta T$ and ensure each part is accounted for. Use this equation instead of plain $\sigma = E\epsilon$ when thermal effects are present; use it instead of $\sigma = E\alpha\Delta T$ when the member is not fully fixed (or has additional load). It reduces to those simpler cases if you plug in the appropriate values (for free expansion: $\epsilon_{\text{total}} = \alpha\Delta T$ gives $\sigma = 0$; for fully fixed: $\epsilon_{\text{total}} = 0$ gives $\sigma = -E\alpha\Delta T$ as expected).

Common exam traps:

- **Ignoring thermal strain in indeterminate problems:** If a problem mentions temperature change and the structure has multiple supports or members, don't forget to include $\alpha\Delta T$ in your strain or deformation equations. It's easy to write equilibrium $F_1 + F_2 = \cdots$ and forget the extra expansion term in compatibility. Look out for keywords like "statistically indeterminate", "both ends fixed", "two materials", or any temperature mention in a deformation problem – these flag that $\alpha\Delta T$ is needed in your equations.
- **Superposition sign errors:** When adding mechanical and thermal strains, keep track of signs. Suppose a rod is in tension from a load (positive ϵ_{mech}) but then cools (negative $\epsilon_{\text{thermal}}$ because it wants to contract). These work against each other: cooling will reduce the total elongation or even cause net contraction. Your formula $\epsilon_{\text{total}} = \sigma/E + \alpha\Delta T$ will have $\alpha\Delta T$ negative in that case. If you move terms around, be careful to not lose a minus sign. A good practice is to define an axis (say, tension and expansion as positive), then stick to it.
- **Multiple members / load sharing:** In a system of different members (like two rods supporting a plate), it's easy to assume they see the same force or same stress. Indeterminate structures often distribute load based on stiffness. If one rod is hotter, it might carry more force (if it expands against the plate) or less (if it slackens a bit under tension). You typically set up: deflection of rod1 = deflection of rod2 (compatibility) and force sum = total load (equilibrium). The thermal term will appear in the deflection expressions. Don't just average forces or something – use the proper relations.
- **Forgetting other effects:** If the problem involves thermal expansion plus something like **creep** or **temperature-dependent E**, those are probably beyond FE level – likely not in this exam's scope. Stick to linear elastic plus thermal only, unless the question explicitly introduces another concept.

Example scenario (conceptual): Imagine a steel tie-rod in a frame that is pre-tensioned and then the whole frame's temperature drops. The rod was under tension (mechanical load) and cooling makes it want to contract. If the frame doesn't allow it to shorten (it was pinned at set length), the rod's tension will either increase or decrease? Using the formula: initial $\sigma_{\text{initial}} = \frac{P}{A}$ from pre-tension. Cooling by ΔT: $\alpha\Delta T$ is negative. If the frame is rigid (rod length fixed), then $\epsilon_{\text{total}} = 0$ still. Plug in: $0 = \sigma/E + \alpha\Delta T \Longrightarrow \sigma_{\text{new}} = -E(\alpha\Delta T)$. Since $\alpha\Delta T$ is negative, $-E(\alpha\Delta T)$ is positive – tensile. The magnitude $E|\alpha\Delta T|$ might add to or subtract from the original P/A depending on how we superimpose (in this case, the rod was already at some stress, and cooling pulled it more, increasing tension). This kind of reasoning can show up in qualitative questions ("what happens to stress when…?").

Variations and related cases:

- Thermal expansion in frameworks: In trusses or frames, a member's thermal expansion can cause complex forces. The approach is the same: incorporate αΔT into the deformation equations. A common variant: a pin-jointed truss that is statically determinate (no redundant supports) won't develop thermal stress internally because it can deform – but it will cause displacements. A statically indeterminate truss (say a triangle truss with fixed supports at both ends) will develop internal forces if heated or cooled.

- Beam expansion and bending: Uniformly heating a simply supported beam will just make it longer (it might bend if it can't expand freely horizontally, but if one support can roll, no bending occurs [^5]). Non-uniform heating (temperature gradient through depth of beam) causes thermal curvature – one side expands more than the other – effectively bending the beam. That's a more advanced topic; the FE exam might touch on the concept qualitatively (e.g. "the top of a beam is heated more than the bottom – what happens? -> it bends"). The calculation for that involves an "equivalent moment" from differential expansion.

- Thermal stress vs pressure stress: Occasionally a question might juxtapose thermal stress with another cause. For example, a thin hoop (like a metal ring) warmed and fitted over a wheel (shrink fit) – as it cools it wants to contract but the wheel resists, causing tensile hoop stress. This is thermal stress combined with interference fit concepts. The safe way to handle it: find the "strain misfit" (difference between free contraction and actual allowed contraction) and use $\sigma = E(\Delta\varepsilon)$ much like above. Realize that thermal stress problems often mirror other "pre-strain" problems (like a misfit length or initial strain problem) – the math approach is the same.

Exam Handbook Search Cues (Not affiliated with or endorsed by NCEES): strain compatibility, member force method, thermal strain energy. (While the handbook may not spell out step-by-step solutions, it provides the base formulas: look for the fundamental $\epsilon = \sigma/E$ (Hooke's law) and $\delta = \alpha L \Delta T$ entries. The Civil Engineering section of the handbook (if accessible) even shows how to incorporate a $\alpha L \Delta T$ term in deflection calculations and force method equations – e.g., search for "member misfit" or "temperature change in member" in the handbook index for an example of including thermal effects in structural analysis.)

[^5]: **Thermal deflections in beams/trusses:** For a statically determinate structure, a uniform temperature change will typically result in expansion or contraction that is accommodated by support movement, not internal stress. For instance, a simply-supported beam can expand by pushing a roller support, no stress, just displacement. No vertical deflection occurs in that case because the beam just gets a tiny bit longer and the roller moves. In contrast, if both supports were fixed (making it indeterminate) and the beam was heated, it *couldn't* expand freely – it would likely buckle or develop compressive stress (an analogy: like a long rod fixed and heated). The FE exam usually sticks to axial members for thermal stress problems, but keep in mind the support conditions matter greatly for whether a thermal effect causes stress or just deflection.

K08.T07.S04 – Including Thermal Effects in Deflection Calculations

Topic introduction: Thermal expansion can contribute to the **deflection of structures**, not just internal stress. When solving deflection problems (for example, finding how far a joint in a truss moves or how much a beam deflects), you must account for any deformations caused by temperature changes in members. The exam may present a scenario like a pin-jointed truss where one or more members heat up or cool down, asking for the resulting displacement at a point. A systematic way to handle this is by using the **unit-load method (virtual work)** or simple superposition, treating thermal elongations as predetermined *deformations* in the structure.

Key technique – Unit-Load Method for thermal deflection: The unit-load method is a powerful tool to find deflections. Normally, to find deflection at a point, you apply a "virtual" unit load at that point (in the direction of desired deflection), find internal forces $f_i^{(unit)}$ in each member, and use the formula:

$$\delta_{\text{point}} = \sum_{i \text{ members}} \frac{f_i^{(unit)} F_i^{(\text{actual})} L_i}{A_i E_i},$$

where $F_i^{(\text{actual})}$ are the real internal forces in member i from the actual loads. This accounts for energy/work due to those forces.

However, for thermal expansion, members might change length without any actual force F_i from external loads (if the structure is determinate, thermal expansion doesn't induce internal force). In such cases, the above formula would misleadingly give zero (since $F_i^{(\text{actual})} = 0$ for a free expansion in a determinate truss). The trick is to instead incorporate the thermal deformation directly into the virtual work summation. We treat the thermal elongation $\Delta L_i^{(\text{thermal})} = \alpha_i L_i \Delta T_i$ of each member as if it were a "given deformation." The deflection at the point of interest due to these thermal changes is:

$$\delta_{\text{thermal}} = \sum_{i \text{ members}} f_i^{(unit)} \, \Delta L_i^{(\text{thermal})},$$

summing over all members that undergo a temperature change. Here $f_i^{(unit)}$ (the internal force from the unit load in member i) acts like a weighting factor for how much that member's expansion influences the point's deflection. Essentially, we're doing work = force × deformation for each member (the unit load provides the "force" and the thermal expansion provides the "deformation").

- If $f_i^{(unit)}$ is tensile (member i would be stretched by the unit load) and the member actually got longer from heat, it will push the structure in the direction of the unit load's deflection – contributing positively to δ_{thermal}.
- If a member contracts (cooling, ΔL negative) and $f_i^{(unit)}$ was tensile, that contraction will pull the joint opposite to the unit load direction, contributing a negative deflection (or effectively, it moves the joint in the opposite direction).
- If $f_i^{(unit)}$ is zero (the member doesn't carry force for that deflection mode), then that member's thermal change doesn't influence the chosen deflection (which makes sense: if the member isn't involved in that deformation, its expansion just goes into slack or pushes some other support).

In summary, **to include thermal effects in deflection: compute the free thermal expansion of each member and add its influence using the structure's flexibility**.

Procedure outline:

1. Identify affected members: Determine which members have a temperature change and calculate each one's free length change $\Delta L = \alpha L \Delta T$. Pay attention to sign (expansion vs contraction).

2. Choose the deflection of interest: For example, "vertical deflection at joint A" or "horizontal displacement of support". This is where you'll apply a unit load (1 unit force or 1 unit moment depending on deflection type) in the virtual work method.

3. Do a virtual analysis: Apply a 1-unit load at that point in the direction of desired deflection. Solve for internal member forces $f_i^{(unit)}$ due to this unit load (tension positive).

4. Compute thermal deflection: Use $\delta_{\text{thermal}} = \sum f_i^{(unit)} \Delta L_i^{(\text{thermal})}$, summing over all members. (If working by hand, keep track of signs: if a member is in compression under the unit load, and it expanded, how does that affect the deflection? A compression $f_i^{(unit)}$ means the unit load would shorten that member, but the actual expansion lengthened it; effectively, that member's expansion might push the joint opposite the assumed unit load direction, giving a negative contribution. It can be a bit confusing, but usually consistency in sign convention sorts it out.)

5. Add mechanical deflection (if any): If the problem also has external loads causing deflection, you would separately compute the deflection from those (using standard methods) and then add the thermal deflection to get total deflection.

For simpler cases, you might not need the full unit-load method. If only one member expands and you want the deflection at a joint it's connected to, you can often use geometry/trigonometry. For example, in a two-bar truss (triangle), if one bar lengthens, you can compute how the joint angle changes and hence vertical deflection. The unit-load method is just a systematic way to handle any configuration.

Common exam application: A typical FE question might give a pin-jointed truss with a specified temperature increase in one member and ask how far a certain joint moves. If the truss is statically determinate (which many exam trusses are), no internal stress is caused by the temperature (the truss will just deform). So you focus on deflection. You can often use symmetry or simpler reasoning if applicable (e.g. "both bottom chords of a symmetric truss heat up, the top joint rises evenly"). But the safest general approach is the virtual work method described.

Pitfalls and checks:

- Don't confuse thermal deflection with thermal stress. In a determinate structure, thermal expansion causes deflection but zero stress; in an indeterminate structure, it causes both stress and perhaps some deflection (depending on support flexibility). Make sure you address what the question is asking: "internal force" vs "movement." - Interpolation or proportion tricks: Sometimes, rather than doing full calculations, you can reason proportionally. For example, if you know a certain force causes X deflection, you might find what force would cause the same deflection as the thermal expansion. In fact, that's what the unit load method is implicitly doing. Some students try to shortcut: "Member expanded ΔL, that's equivalent to a force that would elongate it ΔL, then find deflection from that force." This works if done carefully (by essentially computing an equivalent load F_{eq} via $\Delta L = F_{eq} L/(AE)$, etc.), but it's easy to mess up. The formal unit-load method keeps it clear and is less prone to sign errors.

- Non-uniform temperature effects: If a structure has different ΔT in different members, just compute each ΔL accordingly. If a temperature change causes bending (like one side of a frame heats up), the deflection calculation might need a moment-area or other method – but such problems are rare in FE; most are axial member expansions.

Exam Handbook Search Cues (Not affiliated with or endorsed by NCEES): *unit load method*, *deflection*, *thermal expansion in truss*. *(The FE Reference Handbook (Civil Engineering section) explicitly outlines the unit-load method for deflections and notes how to include "change in length caused by… temperature change in member". While Mechanical examinees may not automatically look at the Civil section, remember that the principles are the same. If stuck, search the PDF for "αL" or "temperature change in member" to find if the reference has a hint. But ideally, know the method so you don't waste time searching.)*

Special Notes: On the exam, problems on thermal stress/strain are often straightforward plug-and-chug with $\Delta L = \alpha L \Delta T$ or $\sigma = E\alpha\Delta T$. The more complex scenarios (combined loading, deflection) are usually one step up in difficulty, requiring you to write a compatibility or use superposition. Practice a couple of indeterminate support problems with thermal expansion (e.g., a composite rod, or a clamped bar with an applied load and a temperature change) so you're comfortable with the concept. And as always, mind your units and sign conventions. A quick mental check: expanding freely → no stress; fixed → high stress; partial → some of each. If your answer for a fully free expansion case had stress, or a fully fixed case had a length change, something's off. Use these physical sanity checks to catch mistakes before finalizing your answer on exam day. Good luck, and remember that a cool head (no thermal pun intended) prevails even when problems heat up!

Topic 08 - Combined Loading

Topic Introduction: Combined loading refers to structures subjected to more than one type of load at the same time – for example, a shaft in tension that is also bending, or a beam carrying both bending and torsion. On the FE Mechanical Exam, you'll encounter problems where you must **superimpose stresses** from axial forces, bending moments, and torques, then determine critical stresses or check against failure criteria. This topic matters because real components are rarely under just one simple load, and exam questions often test your ability to handle **multi-mode stress states**. A typical question archetype is giving a member with combined loads and asking for a resulting **principal stress**, **safety factor** (using yield criteria like von Mises), or identifying whether a thin-walled pressure vessel can handle a given internal pressure. The skills here involve linear superposition of stress effects, using **Mohr's circle** or formulas for stress transformation, and applying yield theories to combined stresses.

K08.T08.S01 – Superposition of Stresses from Multiple Loads

Principle Introduction: When a structural member is subjected to multiple loads (axial force, bending moment, torsion, etc.) at the same time, the **Principle of Superposition** allows us to calculate the stress from each load separately and then add them together for the total stress, as long as the material behavior is linear-elastic and deformations are small (so one load's effect doesn't significantly alter the effect of the others). Key points include:

- **Linearity:** Superposition only works under linear conditions (Hooke's law). If each load produces a stress distribution proportional to that load, then summing the loads' effects is valid. This typically means stresses remain in the elastic range and deflections are small (no yielding or geometric nonlinearity).
- **Same Stress Type Addition:** Stresses of the same type (e.g. two sources of normal stress, or two sources of shear stress on the same plane) can be added algebraically (taking tension/compression sign into account). For instance, a **tensile axial load + bending** that causes tension on the same side of the cross-section will produce a larger tensile stress when added. If the bending causes compression on that side, it will subtract from the axial tension.
- **Different Stress Types:** If loads produce different kinds of stress at a point (e.g. a bending moment causes a normal stress while a torque causes a shear stress), you **cannot directly add normal and shear stresses** as a single number – instead, you combine them as a state of stress and typically find resultant effects (principal stresses or equivalent stress) using transformation methods (enter **Mohr's circle**, next subtopic). Superposition still applies in that each stress component (normal in x, normal in y, shear in xy, etc.) is the sum of contributions from each load.
- **No Interaction (Hidden Assumption):** The presence of one load should not significantly change the effect of another. For example, **no plastic deformation** from one load that would change stiffness for the other, and **no large deflections** that alter geometry. Under these conditions, the combined stress state is simply the sum of individual stress states.

Equation – Combined Normal Stress (Axial + Bending): This equation gives the normal stress at a point in a beam or rod subjected to both an axial force and a bending moment (about one principal axis). It's essentially the superposition of uniform axial stress and linear bending stress:

$$\sigma_{\text{total}}(y) = \frac{P}{A} \pm \frac{M\,y}{I}$$

- P/A **(Axial stress)** – Uniform normal stress due to an axial force P (tension if P is positive, compression if negative) over cross-sectional area A. Units: Pa (N/m²) or psi.
- $M\,y/I$ **(Bending stress)** – Normal stress due to bending moment M at a distance y from the neutral axis. I is the second moment of area about that axis. The $\pm$ sign indicates the stress **increases linearly with** y, positive on one side of the neutral axis and negative on the other. (Tensile on the convex side of bending, compressive on the concave side, assuming M is positive in sign convention.) Units: Pa or psi (consistent with axial stress).
- **Assumptions & Scope:** Linear elastic material (Hooke's law holds); plane sections remain plane (Bernoulli beam theory) so bending stress varies linearly with y; P and M are static loads applied about axes such that their effects superpose without coupling. **Small deflection** is assumed so that geometry doesn't change (the axial load doesn't start producing bending, etc.).
- **Limit Checks:** If $M = 0$, the formula reduces to $\sigma = P/A$ (pure axial stress) – a sanity check that bending contributes nothing when absent. If $P = 0$, it reduces to $\sigma = My/I$, the usual bending stress. At the neutral axis ($y = 0$), $\sigma_{\text{total}} = P/A$ – bending contributes zero at that fiber, so only axial stress remains. As y increases to the outer fiber c, σ_{total} reaches extrema $\frac{P}{A} \pm \frac{Mc}{I}$; if one of these extremes goes to zero it indicates a switch from tension to compression on that side (e.g. bending opposite to axial). As a rough check, if y is very small, bending's effect is negligible and $\sigma_{\text{total}} \approx P/A$. If the cross-section is symmetric and M is large, one side may see high tension while the opposite side sees high compression – superposition handles that with the $\pm$ term.
- **Use vs. "Sibling" Equations:** *Use this combined formula instead of treating axial and bending separately whenever a member experiences both an axial force and a bending moment simultaneously.* It saves time over computing stresses individually and then combining. For pure bending alone, you'd use $\sigma = Mc/I$ (or $\sigma = My/I$ at a given fiber); for pure tension/compression alone, $\sigma = P/A$. This superposition simply *sums those*. (If torsion is also present, you cannot directly include it here since that produces shear stress, not normal stress – you would handle that by considering shear stress separately and moving to a Mohr's circle or von Mises calculation for combined normal + shear effects.)
- **Common Exam Traps:** (1) **Sign confusion:** It's easy to forget which way bending stress is tensile vs. compressive. Always define a positive y direction

(usually upward from neutral axis) and be consistent with the bending moment sign (usually compressive on top fibers for positive M in beam sign convention). If you mix these up, you might add when you should subtract. A quick way to avoid sign errors: solve for stress on each side separately (e.g. top fiber vs bottom fiber) by intuitively knowing which side is in tension/compression, then combine with axial. (2) **Unit mix-ups:** Ensure P, A, M, I, and y are in consistent units. For example, M in N·m with I in m⁴ gives Pa for stress; if M is given in lbf·in and I in in⁴, convert one or use them consistently to get stress in psi. (3) **Using the wrong y or I:** Use the y distance for the specific point where stress is asked (usually outer fiber for max stress, where $y = c$ = half the depth for symmetric sections). I should be about the neutral axis corresponding to the bending plane. (4) **Applying superposition outside elastic range:** If the combined σ_{total} exceeds yield, technically the material would yield and the linear superposition assumption breaks down. Exam problems will typically keep stresses within elastic range unless they explicitly ask about yielding.

Exam Handbook Search Cues (Not affiliated with or endorsed by NCEES): *principle of superposition; combined loading; axial stress; bending stress; torsional stress* (look for these terms in the exam reference – they signal formulas for combining stresses linearly)

Variations and Related Forms: In general, superposition can be extended to any number of loads: $\sigma_{\text{total}} = \sigma_1 + \sigma_2 + \cdots$ for all individual load cases. For example, if a beam has **two different bending moments** about perpendicular axes (bi-axial bending), the normal stress at a point is $M_x y/I_x + M_z x/I_z$ (summing bending stresses from each axis separately). If a member has **multiple axial loads** or nonconcurrent forces, you still sum their P/A effects (provided the net effect is uniform tension/compression). The *concept* remains: calculate each stress effect independently (axial, bending in plane 1, bending in plane 2, etc.) and add them. Also, remember the bending stress formula can be expressed in terms of section modulus S: $\sigma_b = M/S$, so sometimes you'll see combined stress written as $\sigma = P/A \pm M/S$ – this is just the same formula using $S = I/c$. There is no "interaction" term in linear superposition – simply a sum – which is a big clue that the underlying behavior must be linear.

Special Note: Your FE exam-approved calculator can handle this superposition easily by computing each part separately. It's wise to calculate P/A and My/I independently, then add, to reduce chances of algebraic error. For instance, compute axial stress, then bending stress (take care of the sign manually), then sum. This way you're less likely to mis-enter a combined formula into the calculator. Also double-check the sign of y: many mistakes happen by plugging $y = c$ as a positive number without considering if the stress is tensile or compressive there – decide the sign before adding.

Explanation & Analysis: The above formula is fundamentally an application of **stress superposition in the elastic regime**. Here's what it means step-by-step: imagine your member under just the axial load P – every fiber across the section feels $\sigma = P/A$ (tension or compression uniformly). Now imagine it under just the bending M – fibers at $+y$ from neutral axis feel $\sigma = +My/I$ (say tension), at $-y$ feel $-My/I$ (compression). When both loads act together, **every fiber's total normal stress is just the sum** of what each load would cause alone. This works because in elastic materials, strains and stresses add up linearly (no surprise extra stress from combining them aside from the direct sum). Physically, if P is tensile and M puts the bottom fiber in tension too, that bottom fiber's total tension is higher (adding). The top fiber might get tension from P but compression from M; if M's effect is larger, the top could even net out to compression (if $\frac{My}{I} > \frac{P}{A}$). Superposition lets you handle that scenario by algebra, rather than solving a whole new equilibrium problem. Each symbol: P is the force trying to stretch or compress the member (Newtons or pounds-force); A is the cross-sectional area resisting that (m² or in²); M is the bending moment (N·m or lb·ft, etc.) trying to bend the member about an axis; I is the second moment of area about that bending axis (m⁴ or in⁴); y is how far from the neutral axis (centroidal axis for symmetric sections) the point is (m or in). Notice that My/I has dimensions of stress (since M in N·m times m divided by m⁴ gives N/m²), and it grows linearly with y. The outermost fibers (largest $|y|$) see the maximum bending stress. One common pitfall is misidentifying y: on a rectangular beam, if the total depth is h, then $c = h/2$ is the max y. Plugging y larger than that is non-physical. Another pitfall: forgetting that if P is compressive (negative) and My/I is tensile (positive) at a fiber, you should subtract the numbers (effectively adding a negative). Always keep track: tension vs compression. In summary, this formula is your go-to for quickly **evaluating combined axial + bending scenarios** on the exam – just plug in the values, mind the signs, and you've got the stress. If the problem involves also a torsion or shear component, you'll carry those separately (for shear stress) and then move to the next steps (Mohr's circle or yield criteria) to fully analyze the combined state, as we'll see next.

K08.T08.S02 – Mohr's Circle for Combined Stress States (Principal Stresses)

Principle Introduction: When a material element is under combined stresses (for example, a normal stress in one direction and a shear stress on the plane, as from bending + torsion), we often need to find the **principal stresses** – the normal stresses oriented at some angle where shear is zero and the normal stresses are extremal. **Mohr's circle** is a graphical method to transform stresses and find these principal values and directions for a 2D stress state. In the context of the FE exam, Mohr's circle provides a visual and intuitive way to handle **stress transformation**, although you can also use transformation equations directly. Key points about Mohr's circle and principal stresses:

- **Combined Stress State:** Consider an element in plane stress with a normal stress σ_x (e.g. from axial or bending) on the x face, another σ_y on the perpendicular face (could be from bending in another direction or some other load, or zero if only one normal stress is present), and a shear stress τ_{xy} (e.g. from torsion or transverse shear). This is a **2D stress state** (σ and τ on orthogonal planes). We want the **principal stresses** σ_1 and σ_2 – the eigenvalues of the stress matrix – which are the maximum and minimum normal stresses at some rotation, and the **maximum shear stress** $\tau_{\max}$ in the plane.
- **Mohr's Circle Concept:** Mohr's circle plots normal stress (σ) on the horizontal axis and shear stress (τ) on the vertical axis. Each state of stress on a plane corresponds to a point on this graph. For the element's original orientation, we plot a point for the x face stress (σ_x, τ_{xy}) and for the y face $(\sigma_y, -\tau_{xy})$ – these two points are diametrically opposite on Mohr's circle. The circle drawn through them (with its center on the σ axis) represents all possible stress states as you rotate the

element. The **principal stresses** lie where the circle intersects the horizontal axis (shear = 0), and the maximum shear stress is the top/bottom of the circle. The center C of the circle is at $\left(\frac{\sigma_x+\sigma_y}{2}, 0\right)$ and the radius R is the distance from the center to either point, which is $\sqrt{\left(\frac{\sigma_x-\sigma_y}{2}\right)^2 + \tau_{xy}^2}$.

- **Finding Principal Stresses:** From the above, the principal stresses can be calculated as: $\sigma_{1,2} = C \pm R = \frac{\sigma_x+\sigma_y}{2} \pm \sqrt{\left(\frac{\sigma_x-\sigma_y}{2}\right)^2 + \tau_{xy}^2}$. These are the two principal normal stresses (σ_1 being the larger, σ_2 the smaller). The angle θ_p from the original x axis to the σ_1 principal direction can also be found (Mohr's circle geometry or formula $\tan 2\theta_p = \frac{2\tau_{xy}}{\sigma_x-\sigma_y}$), though on the FE exam you're usually only asked for the principal *values* or max shear, not the exact angle. Note that if $\sigma_y = 0$ (common case: one normal stress and one shear), this formula simplifies accordingly.
- **Max Shear Stress:** The maximum in-plane shear stress $\tau_{\max}$ is equal to the radius R of the circle. It occurs on planes oriented 45° from the principal planes. In 2D (plane stress), $\tau_{\max}^{\text{in-plane}} = R = \sqrt{\left(\frac{\sigma_x-\sigma_y}{2}\right)^2 + \tau_{xy}^2}$. However, consider if there's also a third stress (out-of-plane $\sigma_z = 0$ in plane stress assumption): the absolute max shear in 3D might be half the difference between the out-of-plane principal (which is zero) and the largest in-plane principal. In practice, if $\sigma_3 = 0$, then $\tau_{\max,3D} = \frac{\sigma_1-0}{2} = \sigma_1/2$ if σ_1 is much larger than $\sigma_2 = 0$. But for exam plane stress problems, usually $\tau_{\max} = R$ suffices unless they explicitly mention a zero third stress.
- **When to Use Mohr's Circle:** On exam day, you might use Mohr's circle conceptually to double-check principal stress calculations or when dealing with transformation (like finding stress on a plane at a given angle). If you're not graphically drawing it (which is time-consuming), you can rely on the **principal stress formulas** above. Still, understanding Mohr's circle helps prevent errors: it gives a visual check (e.g., σ_1 should lie between σ_x and σ_y if τ is zero, etc., and shear should be zero at principal stresses). It's also useful for **sign convention clarity** – tensile stresses plot to the right (positive σ), shear plotting up or down depends on the couple direction (the exam handbook defines a convention for Mohr's circle where a clockwise in-plane shear on an element plots upward).

Mohr's Circle for a combined stress state. In this diagram, the red points represent the stress on the x face (σ_x, τ_{xy}) and on the y face $(\sigma_y, -\tau_{xy})$ for a given element. The blue circle is Mohr's circle passing through these points. The center of the circle C is located at $\left(\frac{\sigma_x+\sigma_y}{2}, 0\right)$ on the horizontal axis (marked "Center (C)" in blue), and the radius R is indicated. The intersections of the circle with the horizontal axis (green squares) are the principal stresses σ_1 and σ_2, where the shear stress is zero. The top of the circle gives the maximum in-plane shear stress $\tau_{\max}$ (magnitude equal to R). The axes are labeled in units of stress (e.g., MPa). Mohr's circle provides a geometric way to find $\sigma_1, \sigma_2, \tau_{\max}$ and to visualize how rotating the element changes the stress state. Notice how one red point is above the axis and the other is below – they are symmetric about the center, reflecting shear on perpendicular faces being equal and opposite.

Exam Handbook Search Cues (Not affiliated with or endorsed by NCEES): *Mohr's circle; principal stresses; stress transformation; maximum in-plane shear* (these keywords will point you to equations or guidance on finding principal stresses in the exam reference).

Footnotes / Clarifications: Keep in mind sign conventions – in Mohr's circle **the sign of shear is a plotting convention**. The exam handbook convention (commonly used) is that a pair of shear stresses that tends to rotate the element clockwise is plotted as a positive point (upwards) on Mohr's circle. If you ever forget the formula, you can derive principal stresses quickly by solving the equilibrium of an element rotated by θ (or just memorize the formula given above, which is provided in the reference). Also, principal *strains* have analogous formulas if needed (though in this topic we focus on stresses).

Variations and Special Cases: If the element has **only one normal stress and a shear** (common case: e.g. $\sigma_x =$ something, $\sigma_y = 0, \tau_{xy} \neq 0$), then one of the principal stresses will be tensile and one compressive (if shear is nonzero). For example, a shaft under pure torsion ($\sigma_x = 0, \sigma_y = 0, \tau_{xy} = \tau$) will have principal stresses of equal magnitude but opposite sign: $\sigma_{1,2} = \pm\tau$ – meaning pure shear yields principal tension and compression of magnitude τ. This is consistent with Mohr's circle: if $\sigma_x = \sigma_y = 0$, $C = 0$ and $R = |\tau|$, so the circle crosses the axis at $+|\tau|$ and $-|\tau|$. Another special case: if the stress state is **uniaxial (only $\sigma_x \neq 0$, others zero)**, then $\sigma_1 = \sigma_x$, $\sigma_2 = 0$ (and $\tau_{\max} = |\sigma_x|/2$ occurs on planes at 45°). If the state is **biaxial with no shear** (just two perpendicular normal stresses, $\tau = 0$), then the principal stresses are just those two values (one could be larger) – no rotation needed unless you want to swap their order. It's also good to note that Mohr's circle can be drawn for **strain** or **moment of inertia** calculations too, but in Mechanics of Materials context here, it's specifically for stress. On the exam, if you're short on time, using the formula for $\sigma_{1,2}$ is faster than graphing a Mohr's circle, but mentally visualizing the circle can help catch mistakes (like ensuring σ_1 is between reasonable bounds or that $\tau_{\max}$ isn't bigger than it should be).

Special Notes: If you need to compute principal stresses by hand, a straightforward approach on the FE exam calculator is: compute the center $C = (\sigma_x + \sigma_y)/2$. Compute the radius $R = \sqrt{\left((\sigma_x - \sigma_y)/2\right)^2 + \tau_{xy}^2}$. Then $\sigma_1 = C + R$, $\sigma_2 = C - R$. Be mindful of squaring a possibly negative $(\sigma_x - \sigma_y)/2$ – since you square it, you won't lose anything by sign, but ensure the subtraction is correct. It's wise to use parentheses: e.g., in the calculator, (sigma_x - sigma_y) then divide by 2, square it, add τ^2, etc. Also note that the square root will give a positive R; σ_2 could come out negative if one principal is compressive, which is fine. Double-check that $\sigma_1 + \sigma_2 = \sigma_x + \sigma_y$ (trace of the stress matrix invariant) as a quick consistency check. This equality should hold; if not, you mis-entered something.

Explanation & Analysis: The Mohr's circle method is essentially a visualization of the **stress transformation equations**. The formula for $\sigma_{1,2}$ given above comes from solving the eigenvalue problem for the stress tensor in 2D (or simply from geometry of the circle). Let's break down the formula: $\frac{\sigma_x+\sigma_y}{2}$ is the average stress – the center of the circle. The term under the square root $\left(\frac{\sigma_x-\sigma_y}{2}\right)^2 +$

τ_{xy}^2 is like the "variance" in stress between the x and y faces, plus the shear effect. If $\tau_{xy} = 0$, it reduces to $\left(\frac{\sigma_x - \sigma_y}{2}\right)^2$, so $\sqrt{\ldots} = \frac{|\sigma_x - \sigma_y|}{2}$, and $\sigma_{1,2} = \frac{\sigma_x + \sigma_y}{2} \pm \frac{\sigma_x - \sigma_y}{2}$ which is just σ_x and σ_y – makes sense: with no shear, the principal stresses are just the original normal stresses (no change of orientation needed, they are already principal). If $\sigma_x = \sigma_y$, the formula yields $\sigma_{1,2} = \sigma_x \pm |\tau_{xy}|$ – so one principal is higher by τ, one lower by τ; in fact, if $\sigma_x = \sigma_y$ you had a *pure shear* case relative to that average, and indeed the principal axes are at 45°. The maximum shear $\tau_{\max} = R$ in plane is intuitive: it's half the difference between σ_1 and σ_2 (because on Mohr's circle, the top point's τ is radius and its σ coordinate is midpoint between σ_1 and σ_2). If σ_1 and σ_2 are far apart, that difference/2 is large – indicating a big shear. In contrast, if σ_x and σ_y are equal (like a hydrostatic stress case or both tension), and $\tau = 0$, then $\sigma_1 = \sigma_2$ and $\tau_{\max} = 0$ – indeed a state of equal tension in both directions has no shear in any orientation. In practical terms, principal stresses are used to check failure (materials often fail when principal stress or strain reaches a limit) and to understand extreme loading on an element. Mohr's circle is not strictly necessary to solve FE problems, but it is extremely useful for understanding what's happening and avoiding blindly plugging numbers. For instance, if you get a negative number under the square root, that's impossible (it would mean complex principal stresses – indicating you probably mixed up something like using stress units inconsistently). Or if you find a principal stress that's lower than both given stresses when you *know* there was significant shear, that's suspect – likely an arithmetic mistake. With Mohr's circle in mind, you know σ_1 should be larger than any one of σ_x or σ_y individually if $\tau \neq 0$. The visual check: the circle's diameter must be non-negative, so R formula's radicand must be ≥ 0 always (which it will be if you did the math right). In summary, **Mohr's circle/principal stress calculations** let you go from combined stress components to the extreme stresses and orientations, which is crucial for applying failure criteria in the next step.

K08.T08.S03 – Failure Criteria under Combined Stress (von Mises Yield Criterion)

Principle Introduction: When multiple stresses act on a material, determining if it will **yield or fail** isn't as simple as comparing each stress to a strength limit – we need a combined measure. For ductile materials, the **von Mises yield criterion** (also known as the **distortion energy theory**) is commonly used to predict yielding under combined loading. It provides an equivalent single-axis stress (the **von Mises stress**) that can be compared to the yield strength of the material. Essentially, von Mises theory says that yielding begins when the **distortional energy** in the material (energy due to differences in stress, not hydrostatic) reaches the same level as yield in a simple tension test. Key points:

- **Von Mises Stress Definition:** For a general 3D stress state with principal stresses $\sigma_1, \sigma_2, \sigma_3$, the von Mises equivalent stress is defined as: $\sigma_v = \sqrt{1/2\,[(\sigma_1 - \sigma_2)^2 + (\sigma_2 - \sigma_3)^2 + (\sigma_3 - \sigma_1)^2]}$. In many FE exam scenarios, you're dealing with a **plane stress** case (like combined bending/torsion in a shaft, where $\sigma_3 = 0$ for the out-of-plane stress). In 2D simplification ($\sigma_3 = 0$), this formula reduces to: $\sigma_v = \sqrt{\sigma_x^2 + \sigma_y^2 - \sigma_x \sigma_y + 3\tau_{xy}^2}$, which is the form given in the exam reference. This single value σ_v is the "equivalent" stress that, if it were pure tension, would produce the same distortional strain energy as the actual combined state.
- **Yield Check:** The von Mises criterion says **yield occurs when** σ_v **equals** the yield strength S_y of the material (for ductile materials under static load). In other words, ensure $\sigma_v < S_y$ to stay elastic. For exam purposes, you might be given a yield strength and asked if a part with combined stresses will yield: you compute σ_v and compare. If σ_v exceeds S_y, yielding is predicted.
- **Use for Ductile Materials:** Von Mises is particularly good for ductile metals because it correlates well with experimental results for multiaxial yielding. It ignores hydrostatic stress – e.g., if all three principal stresses are equal (a hydrostatic state), σ_v comes out to 0, meaning no yielding predicted, which matches the fact that hydrostatic pressure doesn't cause yielding by shear distortion. The exam will typically expect use of von Mises for combined stress yield questions unless specified otherwise.
- **Contrast with Tresca:** Another failure criterion is the **maximum shear stress theory (Tresca)**, which says yield begins when $\tau_{\max} = S_y/2$ (in uniaxial yield, max shear is half of yield stress). Tresca is easier in some hand calculations but more conservative (predicts yield a bit earlier) than von Mises. The FE Handbook lists both in contexts of failure theories. If the exam problem specifically mentions "von Mises stress" or "distortion energy," use von Mises. If it says "maximum shear stress theory" or Tresca, the criterion is $\max|\sigma_i - \sigma_j| = S_y$ (which effectively compares $\sigma_1 - \sigma_3$ to S_y for plane stress). Usually, though, the exam will explicitly guide which criterion to apply.
- **Combined Loading Examples:** A classic application is a **shaft under bending + torsion**. The shaft's outer surface sees a normal stress from bending (say σ_x) and a shear stress from torsion (τ_{xy}). We can compute $\sigma_v = \sqrt{\sigma_x^2 + 3\tau^2}$ (since $\sigma_y = 0$ in that case). This resulting σ_v can be directly compared to S_y. Engineers often use this to design shafts: ensure $\sqrt{\sigma_b^2 + 3\tau^2} < S_y$ (or include a safety factor accordingly). Another example: **pressure vessel** with combined hoop and longitudinal stresses – you'd compute $\sigma_v = \sqrt{\sigma_{\text{hoop}}^2 + \sigma_{\text{long}}^2 - \sigma_{\text{hoop}}\sigma_{\text{long}}}$ (since it's biaxial tension with no shear on those planes) to check yield.

Equation – Von Mises Stress (Yield Criterion): The equation for von Mises stress in plane stress form (two in-plane principal stresses σx, σy and shear τxy) is given by:

$$\sigma_v = \sqrt{\sigma_x^2 + \sigma_y^2 - \sigma_x \sigma_y + 3\tau_{xy}^2}.$$

σ_x, σ_y**:** Normal stresses on the perpendicular planes of the element (e.g. along x-axis and y-axis directions). These could be direct stresses from axial load, bending in different directions, or hoop/longitudinal in a vessel, etc. Units: same units as the material strength (Pa or psi). **Sign note:** It doesn't actually matter which is σx or σy or which one is larger in magnitude – the formula will handle it (since it squares them and includes the product). If one of these is zero (common case: one primary normal stress and shear), just set the other to 0. If both are tensile or both compressive, the $-\sigma_x\sigma_y$ term will subtract some value (reducing σv compared to just sqrt of squares). If one is tensile, one compressive, the product term becomes negative (minus a negative yields plus), meaning σv

increases – which aligns with the idea that opposite signed stresses contribute more distortion.

τ_{xy}**:** The in-plane shear stress on those planes. For instance, if we have a torque on a shaft, at a point on the surface τ_{xy} might be the torsional shear, with σ_x from bending and $\sigma_y = 0$. Units: same as σ (Pa or psi). In the formula it's weighted by a factor of $\sqrt{3}$ effectively, indicating shear has a strong effect on yielding.

Assumptions & Scope: The von Mises criterion assumes an isotropic, ductile material yielding in von Mises sense. It's typically used for metals. It's not appropriate for brittle materials (which follow different criteria like maximum normal stress or Mohr-Coulomb). It also assumes static loading (for fatigue or time-dependent, other criteria are used). On the exam, if they mention "yield strength" and multiple stress components, von Mises is generally the intended approach unless stated otherwise. It's derived from the energy of distortion, meaning purely hydrostatic stresses are excluded – which is why the subtraction term is there (if $\sigma_x = \sigma_y$, that part reduces the result).

Limit Checks: If $\tau_{xy} = 0$ and $\sigma_y = 0$, then $\sigma_v = |\sigma_x|$ – meaning in pure uniaxial loading, von Mises just returns the absolute value of the normal stress, which makes sense (yield if that exceeds S_y). If $\sigma_x = \sigma_y$ (say equal tension in two directions) and $\tau = 0$, then $\sigma_v = \sqrt{\sigma_x^2 + \sigma_x^2 - \sigma_x^2} = \sigma_x$ (since $\sigma_x^2 + \sigma_x^2 = 2\sigma_x^2$ and minus σ_x^2 leaves σ_x^2; thus $\sqrt{\sigma_x^2} = \sigma_x$). So equal biaxial tension is as severe as uniaxial tension of the same magnitude – this is a known result: yielding in equal biaxial tension happens at the same stress as yield in uniaxial tension for von Mises (no extra advantage or detriment). If one stress is compressive and the other tensile, the $-\sigma_x\sigma_y$ term becomes plus (because the product is negative), so σ_v increases – e.g. if $\sigma_x = +100$ MPa, $\sigma_y = -50$ MPa, and $\tau = 0$, then $\sigma_v = \sqrt{100^2 + 50^2 - (100 * -50)} = \sqrt{10000 + 2500 + 5000} \approx \sqrt{17500} = 132.3$ MPa, which is higher than either individual stress, reflecting that opposite signs create more distortion (the material is being pulled one way and pushed the other – a harsh condition for yielding). Also, check extreme: if τ_{xy} is huge compared to σ's, $\sigma_v \approx \sqrt{3}\,|\tau_{xy}|$. That factor $\sqrt{3}$ means roughly $\tau \approx 0.577\sigma_y$ would yield the material (since setting $\sqrt{3}\tau = S_y$ gives $\tau = S_y/\sqrt{3} \approx 0.577S_y$). In fact, pure shear yield in von Mises corresponds to $\sigma_v = S_y$ when $\tau = S_y/\sqrt{3}$. That's a known result: von Mises predicts yield in pure shear at about 57.7% of the yield strength in tension. (Tresca would predict 50% of S_y for pure shear yield).

Use vs. Other Criteria: *Use von Mises instead of simple "compare each stress to yield" when stresses are multi-axial.* For example, if you have $\sigma_x = 80$ MPa and $\sigma_y = 80$ MPa (two directions) and $S_y = 100$ MPa, neither alone exceeds 100, but von Mises gives $\sigma_v = 80$ MPa (as we computed, equal biaxial yields same 80) – which is below 100, so safe (no yield). But if one was 120 and the other 0, individually one exceeds yield but we don't even need von Mises to say it's yielded. The power of von Mises is when stresses are moderate in multiple directions: it tells the combined effect. If the problem gives you factor of safety with distortion energy, you'd do $n = S_y/\sigma_v$. If they mention **Tresca (max shear)**, you'd use a different formula: typically $\sigma_{\max} - \sigma_{\min}$ compared to S_y (for plane stress max shear $= (\sigma_1 - \sigma_2)/2$). On the exam reference, you might find a direct formula for σ_v given in terms of M, T, F for a shaft (like $\sqrt{(\text{bending stress})^2 + 3(\text{torsion stress})^2}$) – that is just von Mises in another form.

Common Exam Traps:

(1) **Plugging in the wrong values:** Make sure you use *stress* components in the formula, not loads or moments directly. Sometimes exam problems give you bending moment and torque and expect you to compute stresses then σ_v. Don't mix up formulas: first find $\sigma_x = Mc/I$, $\tau = Tc/J$, etc., then feed into von Mises.

(2) **Forgetting to take square root:** It's easy under time pressure to compute the sum of squares and forget the final sqrt, giving a hugely wrong number (like on the order of stress-squared). Always remember σ_v is in the same units as stress.

(3) **Using wrong criterion:** If the question specifically asks "according to maximum shear stress theory (Tresca) does it yield?", and you use von Mises, you might get a slightly different answer. Read keywords: "von Mises", "distortion energy" → use this formula; "Tresca", "max shear stress theory" → use $\tau_{\max} = S_y/2$ or equivalent principal stress difference; "maximum normal stress theory" (brittle material often) → just check largest stress vs strength.

(4) **Mixing units** (again): ensure all stress components are in the same unit system before combining. If σ_x is in psi and σ_y in psi, τ should also be in psi for the formula. If given in MPa, all in MPa.

(5) **Applying von Mises to brittle materials:** which is not accurate – but the exam usually frames it clearly.

Exam Handbook Search Cues (Not affiliated with or endorsed by NCEES): *von Mises stress; failure criteria; yield theory; Tresca (for comparison)* (these terms in the handbook will bring up the relevant equations and explanations of failure theories, often in the Mechanical Design section for combined loading of shafts).

Variations and Further Insight: The von Mises criterion is one of several failure criteria. For **ductile materials**, von Mises and Tresca are the main ones (with von Mises being slightly less conservative). Numerically, Tresca's condition in plane stress can be written as $\max(|\sigma_x - \sigma_y|, |\sigma_x|, |\sigma_y|) = S_y$ (if one principal is zero), but it's easier to say $\tau_{\max} = S_y/2$ must be checked, where $\tau_{\max} = |\sigma_1 - \sigma_2|/2$. If you compare von Mises vs Tresca: von Mises is $\sigma_v = S_y$ as yield condition, Tresca is $\sigma_1 - \sigma_3 = S_y$ (in 3D, or $\sigma_1 - \sigma_2 = S_y$ in plane stress with zero as third). They often produce close results; for example, in pure shear, von Mises says yield at $\tau = 0.577S_y$, Tresca says at $\tau = 0.5S_y$. If not specified, von Mises is a safe default for ductile. For **brittle materials**, an entirely different approach (like Coulomb-Mohr or just max normal stress >= tensile strength or <= compressive strength) would be used, but those are usually under a different topic. Another related concept: **von Mises strain energy** – rarely needed explicitly on FE but know that von Mises comes from equating distortion energy. Also, **impact of hydrostatic stress:** if you had a situation where, say, a part is under a very high hydrostatic pressure (equal tension all around), von Mises could underestimate failure because brittle fracture could happen due to normal stress. But ductile yield is indeed insensitive to hydrostatic component, which is why von Mises ignores the $\sigma_x\sigma_y$ part partially. On the exam, you likely won't delve into that nuance, but it explains that $-\sigma_x\sigma_y$ term: subtracting the product removes the mean stress contribution.

Special Notes: Computing σ_v by hand is straightforward with a calculator – just be careful with the algebra under the square root. A good tip is to compute intermediate values: e.g., find $A = \sigma_x^2 + \sigma_y^2 - \sigma_x\sigma_y$ first, then $B = 3\tau^2$, then $\sigma_v = \sqrt{A + B}$. Breaking it down helps avoid mistakes. If using the calculator, input as:

$$\sqrt{\sigma_x^2 + \sigma_y^2 - \sigma_x\sigma_y + 3\tau_{xy}^2}$$

Some advanced calculators might let you store values for σ_x, σ_y, τ to reuse easily. Always interpret the result: if σ_v comes out higher than any individual stress, that's expected when there's shear or opposing stresses. If it comes out lower than both σ_x and σ_y, that can happen if σ_x and σ_y are both tensile and close in value (because the difference term reduces σ_v a bit) – that's normal. If σ_v is way lower than both, double-check arithmetic. Once you have σ_v, compare it to yield strength S_y: e.g., $\sigma_v = 150$ MPa vs $S_y = 250$ MPa, so material is safe (no yield). If σ_v was 270 MPa vs $S_y = 250$ MPa, it has yielded (or factor of safety $= 250/270 \approx 0.93$, which is <1). The exam might directly ask for σ_v in a given state, or might indirectly require it to check yielding or compute a safety factor. Remember to answer in the units asked (often they'll provide strengths in MPa or psi, so give σ_v in same).

K08.T08.S04 – Thin-Walled Pressure Vessels (Hoop & Longitudinal Stresses)

Principle Introduction: Thin-walled pressure vessels are common elements (think boilers, pipelines, compressed air tanks) and have **combined stresses** due to internal pressure. In a cylindrical pressure vessel (a long pipe or tank with end caps), two primary normal stresses occur in the wall: the **circumferential (hoop) stress** around the girth, and the **longitudinal stress** along the length. These result from the internal pressure pushing outward. If the vessel is a sphere, the stress is equal in all directions (similar to hoop) and there is no distinct longitudinal stress (because a sphere is symmetric). The "thin-walled" assumption means the wall thickness t is much smaller than the radius ($t \leq 0.1\,r$ is a common rule of thumb), so stress through the thickness is assumed uniform and we neglect variation from inner to outer wall. Key points:

- **Hoop (Circumferential) Stress:** This is the circumferential (hoop) stress: it acts around the cylinder's circumference, tangent to the circular direction (imagine slicing out a thin ring from the wall, it's the stress that tends to pull the ring apart). It arises because internal pressure p is trying to burst the cylinder open along its length, and the **circular cross-section** resists by hoop stress in the wall. For a thin-walled cylinder of radius r and thickness t, the hoop stress is $\sigma_{hoop} = \frac{p\,r}{t}$. It's sometimes denoted σ_θ or σ_{circ} and is the **largest stress** in a thin cylindrical vessel (numerically twice the longitudinal stress for a closed cylinder). This formula comes from considering equilibrium of half a cylinder: pressure * area of half the cylinder end = hoop force * wall area (derivation yields $p \cdot (2rL) = \sigma_{hoop} \cdot (2tL)$ for length L, simplifying to $pr = \sigma_{hoop}t$).
- **Longitudinal (Axial) Stress:** This is the stress along the length of the cylinder (parallel to its axis). It exists if the cylinder has closed ends (end caps) that are also under pressure, which push outward on the end caps and tend to stretch the cylinder lengthwise. For a thin cylinder with internal pressure p, the longitudinal stress is $\sigma_{long} = \frac{p\,r}{2\,t}$. This is half the hoop stress for a cylindrical vessel. Its derivation: consider the force on one end cap (pressure * area = $p\pi r^2$) must be carried by the cylindrical wall's cross-sectional area (the wall is like a tube, cross-section of wall is circumference $2\pi r$ times thickness t). So $p\pi r^2 = \sigma_{long}(2\pi rt)$, giving $\sigma_{long} = \frac{pr}{2t}$. If the ends are open or not supporting pressure (like an open pipe), this axial stress would be near zero (aside from any axial force or something externally).
- **Spherical Vessel Stress:** For a thin-walled **sphere**, the stress in the wall is the same in all directions and it's like the cylinder's hoop (there's no distinction between hoop and long in a sphere). The formula for a thin spherical shell under internal pressure is $\sigma_{sphere} = \frac{p\,r}{2\,t}$. Interestingly, that looks exactly like the cylinder's longitudinal stress (and indeed a sphere's stress is equal to what the cylinder experiences in the longitudinal direction). Another way to derive: a sphere can be thought of as two hemispherical shells – force balance yields the 2 in denominator similarly. So a spherical tank can withstand twice the pressure of a cylinder of the same thickness before reaching the same stress (because the sphere has a more efficient shape stress-wise).
- **Combined Stresses and Significance:** In a pressurized cylinder, at a given point on the wall, you have **two perpendicular normal stresses at once**: one hoop, one longitudinal. These are both tensile. There is also a **through-thickness stress (radial stress)** that goes from p at the inner wall to ~0 at the outer surface for an open to atmosphere vessel. However, for thin walls the radial stress is much smaller than the hoop/long stresses (and the wall is thin, so radial variation is minor), so we typically **neglect radial stress** or treat it as a minor third principal stress (approximately $\sigma_r \approx 0$ at mid-thickness). Thus, the hoop and longitudinal stresses can be taken as the two principal stresses in the plane of the wall. For exam problems, you might just calculate hoop and long. and use those in a von Mises check, or report them as answers. Hoop is larger, so if asked "what is the maximum stress in the vessel wall," that's σ_{hoop}. If asked for "state of stress," give both.

Equation – Thin-Walled Pressure Vessel Stresses: For a cylindrical vessel with internal pressure (and closed ends), and for a spherical vessel, use:

- **Cylindrical (Hoop):** $\sigma_{\text{hoop}} = \frac{p\,r}{t}$
- **Cylindrical (Longitudinal):** $\sigma_{\text{long}} = \frac{p\,r}{2\,t}$
- **Spherical (Meridional):** $\sigma_{\text{sphere}} = \frac{p\,r}{2\,t}$ (in all directions)

(Symbols: p = internal gauge pressure; r = vessel inner radius; t = wall thickness. Ensure consistent units, e.g. p in Pa, r and t in m gives stress in Pa.)

Variables and Units:

- p – Internal pressure (force per area, e.g. Pa or psi). Often given as gauge pressure (difference from outside). If outside is atmospheric (0 gauge), use that value directly.
- r – Radius of the vessel (inner radius in thin-wall assumption; sometimes using mean radius $r_{mean} \approx r_{inner}$ is mentione, but difference is negligible for thin walls). Units: m (SI) or in (US customary).
- t – Wall thickness of the vessel. Units: m or in. Should be much smaller than r for these formulas to hold.
- σ_{hoop}, σ_{long} – Resulting tensile stresses in the wall. Units: Pa or psi (same unit as p if r/t is dimensionless, which it is provided r and t are in consistent length units). Sometimes called σ_θ (hoop, circumferential) and σ_{axial} or σ_z (longitudinal, along axis). In a sphere, sometimes

noted as σ_θ in any direction since it's the same around any great circle.

Assumptions & Scope: *Thin-wall assumption:* $t \leq 0.1r$ roughly. This ensures the stress distribution through thickness is nearly uniform and that using the average hoop stress is accurate. We also assume **uniform internal pressure** and that the vessel is cylindrical with closed ends or spherical. No additional loads (no extra axial force or bending moments on the vessel). Material is homogeneous and isotropic (so it doesn't respond weirdly in different directions). Also assume static load (no dynamic or fatigue consideration here). If the wall is thick (thick-walled cylinder), these simple formulas are not valid – one would need Lame's equations which produce a radial stress gradient and different hoop stress near inner vs outer surface. But thick-wall analysis is usually beyond the FE exam scope unless qualitatively. For FE, they explicitly mention thin-walled.

Limit Checks: As t becomes *very thin*, these stresses $\sigma = pr/(\text{small } t)$ become very large – indeed a vanishingly thin wall can hold almost no pressure (it would yield or burst immediately at low p). As $p \to 0$, obviously $\sigma \to 0$ (no pressure, no stress). If you mistakenly used diameter instead of radius, you'd get $\sigma_{\text{hoop}} = pD/t$ which is double the correct value – a common error to avoid (the formulas use radius!). If you plug in a sphere into the cylinder formulas: for a sphere $\sigma_{sphere} = pr/(2t)$ (same as long.), which is consistent. For a cylinder, note $\sigma_{hoop} = 2\sigma_{long}$. So hoop is the critical one. If asked for principal stresses in the wall: one principal is hoop, one is longitudinal, the smallest principal is the through-thickness (approximately 0 or p compressive on the inside surface, but negligible compared to in-plane).

Use vs. Sibling Equations: *Use these thin-wall formulas instead of complex formulas for thick-walled cylinders when the problem indicates a thin pressure vessel.* The exam may directly give a problem statement like "A thin-walled cylindrical tank of radius R and thickness t is subjected to internal pressure p..." – that's your cue to apply $\sigma_{hoop} = pr/t$ and $\sigma_{long} = pr/(2t)$. If the vessel was thick-walled, you'd need more complicated expressions (Lame's equations) which involve $(r_o^2 + r_i^2)/(r_o^2 - r_i^2)$ etc., not likely required unless a conceptual question. So, for FE purposes, stick to the thin-wall ones unless explicitly told otherwise. Also, use the spherical formula for spherical tanks (don't mistakenly use the cylinder's hoop formula on a sphere or vice versa). If given a cylinder *without* end caps (like a pipe open at ends), do not use $\sigma_{long} = pr/(2t)$ because the ends are not closed – the longitudinal stress would mainly come from any caps or external restraints, which in an open pipe case are zero from internal pressure (the pressure just tries to push the pipe outwards circumferentially and maybe a bit tends to lengthen the circumference, but no net force along open ends).

Common Exam Traps: (1) **Mixing up hoop vs longitudinal:** Students often confuse which one has the factor of 2 in the denominator. Remember: the **hoop stress is larger** (for a cylinder) because the hoop "wraps around" the full circumference (two halves of the cylinder have to hold the pressure on the circular cross-section). The longitudinal only holds pressure over the circular area of the end, which is effectively half the load per unit width compared to hoop. A memory trick: "Hoop is horizontal around, and has the full pressure effect, so no 2; Longitudinal is along length, carrying an end cap, so has half the stress (2 in denom)." Or simply recall $\sigma_{hoop} = 2\sigma_{long}$ for cylinder. (2) **Using diameter instead of radius:** If a problem statement gives diameter, be sure to use $r = D/2$ in the formula. This is a common mistake that doubles your stress erroneously. (3) **Forgetting thin-wall requirement:** If they sneakily give a thickness that's not very small relative to radius, these formulas might be slightly off. But unless they specifically bring up thick-wall, they usually won't require you to correct for that. If t is like 1/5 of r, that's not thin – but exam likely won't go there without telling you to do something else. (4) **Units:** p might be given in say psi and dimensions in inches – converting to a final stress in psi is fine, just keep track. Or p in MPa, dimensions in mm – convert mm to m or convert MPa (which is N/mm²) accordingly. (5) **Using the wrong area for equilibrium:** Derivations aside, just trust the formula. But one pitfall in derivation is sometimes mixing up which area to use (e.g., for hoop, using πr^2 by mistake instead of the projected area $2rL$). In an exam, stick to memorized formula rather than re-derive under pressure, unless you're absolutely sure.

Exam Handbook Search Cues (Not affiliated with or endorsed by NCEES): *thin-walled pressure vessel; hoop stress; longitudinal stress; cylindrical shell; spherical shell* (these terms will bring up the relationships for pr/t and $pr/(2t)$ in the reference – often under Mechanics of Materials or Mechanical Design sections).

Variations and Related Info: If the problem involves **external pressure** instead (like a vacuum inside or a submarine hull under outside pressure), the same formulas can be used in magnitude but the stresses will be compressive. The exam might not focus on that, but it's conceptually similar – check if p is internal or external. Also, **if the vessel isn't cylindrical or spherical** (say a weird shape), these formulas don't apply – but FE won't likely give odd shapes without providing guidance. In some advanced cases, if the vessel has **both internal pressure and axial load or bending** (like a pressurized pipe that's also being stretched), the stresses would superimpose (pressure-induced stresses plus whatever from axial/bending). The principle of superposition still applies: you would calculate hoop and longitudinal from pressure, then add any additional axial stress from external loads. Another thing: **stress concentrations** – thin-wall theory gives membrane stresses. If there are holes or nozzles, actual stress can spike locally, but those are typically design details beyond our scope here (though something to be aware of in practice). For the exam, you might be asked simply for the hoop stress or to compare hoop vs longitudinal, or maybe to plug into a von Mises check as mentioned. For example, a sample question: "A thin-walled cylindrical pressure vessel has $r = 0.5$ m, $t = 10$ mm, internal pressure $p = 2$ MPa. Determine the maximum normal stress in the wall." You'd compute $\sigma_{hoop} = pr/t = 2e6 * 0.5/0.01 = 100e6$ Pa = 100 MPa. Longitudinal would be 50 MPa but hoop is max, so answer 100 MPa. Or they might ask: "The vessel from previous has yield strength 250 MPa, factor of safety 2, will it fail?" You'd maybe compute von Mises: here $\sigma_{hoop} = 100$, $\sigma_{long} = 50$, so $\sigma_v = \sqrt{100^2 + 50^2 - 100 * 50} = \sqrt{10000 + 2500 - 5000} = \sqrt{7500} =$ 86.6 MPa (less than yield/FS=125 MPa, so safe). This illustrates how to combine hoop and long for yield check.

Special Notes: To input these formulas in your calculator, it's straightforward: just do $p * r/t$. The challenge is usually unit conversion: e.g. if p is given in psi and r, t in inches, σ comes out in psi directly (since it's just a ratio times pressure). If p is in say kPa and dimensions in mm, convert kPa to N/mm² (which is MPa/1000) or convert mm to m and use Pa. Another note: sometimes you'll see $\sigma_{hoop} = \frac{pD}{2t}$ in textbooks – that's the same formula because $D = 2r$. Just be cautious if you recall one form or the other. For the FE exam, the handbook provides the formula likely in the pr/t form (since that's common). Also, thin-walled

assumptions imply the stress is constant through thickness, but in reality stress on the inside face is slightly higher than outside (because of p acting on inside). We ignore that difference. The error is small if t is small relative to r. If ever in doubt on a borderline case, the exam would guide you. Finally, when reporting answers, identify if they want hoop or longitudinal or both. "Combined loading" in pressure vessels typically just means recognizing there are two simultaneous tensile stresses (and using maybe combined criteria like above if needed).

Topic 09 - Deformations

Topic Intro: *Deformations* in mechanics of materials are all about how structures **stretch, twist, or bend** under various loads. This topic matters on the FE Mechanical Exam because many questions ask *"how much will this component deform?"* under given forces or temperature changes. You'll encounter archetypal problems like finding the **elongation of a steel rod under tension**, the **angle of twist in a drive shaft**, the **deflection of a beam under load**, or the **expansion of a restrained pipe when heated**. Mastering these deformation formulas not only helps you get those questions right, but also builds intuition for structural behavior (and flags if an answer is physically unreasonable). In exam terms, think of deformations as the *gateway between applied loads and resulting strains* – they tie directly into stress and stability checks. Typical questions will give you dimensions, material properties (like Young's modulus or thermal expansion coefficient), a type of loading, and ask for a deformation (Δ length, rotation, or deflection). The keys are recognizing which formula to use, applying it with consistent units, and understanding the conditions (e.g. is one end fixed or free?). Let's break down the core subtopics and their formulas, one by one, in an **exam-ready** way.

K08.T09.S01 – Axial Deformations (Tension/Compression of Bars)

Principle introduction: When a **straight member is pulled or pushed** along its length, it changes length. This axial deformation follows Hooke's Law in the elastic range and is directly proportional to the force and original length, and inversely proportional to the member's stiffness (cross-sectional area and material modulus):

- **Tension or compression** causes a uniform elongation or shortening distributed over the member's length.
- The **linear strain** is $\epsilon = \delta/L$ (change in length per original length) and relates to stress by $\sigma = E\,\epsilon$ (Hooke's law) for elastic deformation.
- A *longer bar* stretches more under the same force (more length to strain), while a *thicker or stiffer bar* stretches less (greater cross-section or higher E resists deformation).
- **Thermal expansion** similarly produces axial deformation: if the bar's temperature rises, it wants to extend by an amount proportional to the temperature change (unless fully constrained).
- These formulas apply as long as the material remains in the elastic range (no permanent set) and the deformation is small (no significant geometry change). Axial deformation questions on the FE exam usually involve plugging values into a simple formula, often after computing area or checking units.

Exam Handbook Search Cues (Not affiliated with or endorsed by NCEES): *uniaxial loading, elongation, thermal expansion* (for locating relevant equations in the reference manual; e.g. the axial deformation formula or coefficient of thermal expansion).

Equation Passport – Axial Elongation (Hooke's Law in 1D)
Name and purpose: Axial deformation formula – computes the change in length of a prismatic member under an axial load (tension or compression) within the elastic limit. This is the direct result of Hooke's law $\sigma = E\epsilon$ applied over a length.

Equation:

$$\delta = \frac{P\,L}{A\,E}$$

Variables and units:

- δ – axial deformation (change in length), in **meters (m)** or **inches (in)**.
- P – axial force (tensile + or compressive –) applied to the member, in **Newtons (N)** or **pounds-force (lbf)**.
- L – original length of the member (along direction of P), in **m** (SI) or **in** (US customary).
- A – cross-sectional area of the member, in **m²** or **in²**. (For a circular rod, $A = \pi d^2/4$.)
- E – Young's modulus (modulus of elasticity of the material), in **Pascals (Pa)** which is N/m² (or often given in gigapascals, GPa; in US units, psi).

Assumptions and scope:

- **Linear elastic behavior:** The material follows Hooke's law ($\sigma = E\epsilon$) without yielding. The formula gives *elastic* deformation only.

- **Uniform member:** A and E are constant along the length (prismatic member). If the cross-section or material varies, one must break the member into uniform segments or integrate [^1].

- **Uniaxial loading:** The force acts along the member's centroidal axis, producing uniform stress $\sigma = P/A$. No bending, buckling, or shear deformation is involved here.

- **Small deformation:** The change in length δ is small compared to L (so geometry doesn't significantly change and P remains axial). This is usually valid for typical elastic stretches (strains are on the order of 10^{-3} or less).

Limit tests (sanity checks): If $P \to 0$, then $\delta \to 0$ (no load, no stretch – correct). If the bar is extremely stiff ($E \to \infty$) or fat ($A \to \infty$), $\delta \to 0$ (an infinitely rigid or thick member doesn't deform under finite load). If the bar is very long ($L \to \infty$), $\delta \to \infty$ for a given P – indeed a longer bar accumulates more stretch. These trends align with physical intuition: δ grows linearly with P and L, and shrinks with increasing A or E. Always double-check units: a common mistake is to mix up units such that the computed δ comes out off by a factor (e.g., using P in kN and E in Pa directly will yield δ in kilometers! Convert kN to N). [^2]

Use vs. sibling equations: Use this equation for **straight axial members under tension/compression** instead of more complex formulas when the member is uniform and within elastic range. It is essentially derived from $\epsilon = \sigma/E$ and $\epsilon = \delta/L$. If the member is not uniform (varying area A or composite sections), use the more general form $\delta = \int_0^L \frac{P}{A(x)E(x)}\,dx$ (summing small extensions). For **thermal-only expansion**, use the thermal formula $\delta_t = \alpha \Delta T\, L$ (see variations below) – or if both load and temperature change act, their effects superpose (add the deformations). Do **not** use this formula for bending deformations or torsional twists – those have their own expressions (coming up in subtopics S03 and S02). In summary, $\delta = PL/(AE)$ is your go-to for an axial force causing a direct stretch or compression, whereas *beam deflection* or *shaft twist* problems require different equations.

Common exam traps:

- **Unit mix-ups:** Forgetting to convert E into consistent units with P and A. For example, E for steel might be given as 200 GPa – if you plug 200×10^9 Pa with L in mm and A in mm², you'll get δ in millimeters (since Pa is N/m²). It's usually safest to convert everything to base SI: P in N, L in m, A in m², E in N/m², then δ comes out in m [^2].

- **Using diameter instead of area:** Many times a problem gives a diameter (say of a rod or bolt). You must compute the cross-sectional area $A = \pi(d/2)^2$. A common mistake is to plug d into the formula instead of A, which is dimensionally wrong. Double-check you're using area (with correct units) for A.

- **Forgetting total elongation:** If a problem involves multiple segments or multiple rods in series, remember the total deformation is the sum of each segment's δ. If a rod is made of two materials end-to-end, compute each part's deformation and add them (force is same if in series).

- **Ignoring thermal strain:** If the question mentions a temperature change *and* a load, you should add the thermal expansion $\alpha \Delta T L$ to the mechanical deformation $PL/(AE)$ (assuming the structure can freely expand). Neglecting the thermal component or using the wrong sign (expansion vs contraction) can lead to the wrong answer.

- **Plastic deformation not covered:** If the stress P/A exceeds yield, this formula no longer predicts the actual final deformation (plastic strain would add). The FE exam, however, usually stays within elastic scenarios unless explicitly asking about plasticity, so stick to elastic formula unless told otherwise.

[^1]: *Nonuniform members:* When A or E changes along the length (or if dealing with a tapered rod or composite), integrate $\delta = \int_0^L \frac{P}{A(x)E(x)} dx$. For example, a tapered circular bar where diameter increases along its length would have smaller strain in the thicker portions. The exam might avoid integration by giving piecewise segments or by assuming uniform sections.
[^2]: *Unit consistency:* E (Young's modulus) is often given in gigapascals for metals (e.g. $E_{\text{steel}} \approx 200$ GPa). To use $E = 200$ GPa in $\delta = PL/(AE)$ with P in N and A in m², convert E to 200×10^9 N/m². Likewise, if using US units, a common E is 30×10^6 psi; ensure P is in lbf, A in in², and L in inches to get δ in inches. It's helpful to write down units in the calculation to catch errors (e.g. N divided by (N/m²) gives m² which cancels with the m² in L's units to yield m).

Variations, related forms, typical values:

- **Thermal expansion:** A change in temperature ΔT produces a free expansion (or contraction) $\delta_{\text{thermal}} = \alpha\, \Delta T\, L$, where α is the coefficient of thermal expansion. For example, a steel rod ($\alpha \approx 12 \times 10^{-6}$/°C) with $L = 2$ m heated by $\Delta T = 50$ °C will elongate $\delta_t \approx 12 \times 10^{-6} \times 50 \times 2 = 0.0012$ m $= 1.2$ mm. Thermal deformation adds algebraically to mechanical deformation if both load and temperature act (heating generally adds expansion, cooling adds contraction).

- **Composite or segmented members:** If you have, say, a brass segment and a steel segment glued together in line, each segment i will have its own $\delta_i = PL_i/(A_i E_i)$. The total change in length is $\sum \delta_i$ (assuming same P through both, which is true if they're in series). This also applies to a tapered rod approximated as a series of small lengths with gradually changing area.

- **Stiffness and flexibility:** The reciprocal of deformation formula gives a notion of axial stiffness. One can define **axial stiffness** $k = P/\delta = AE/L$ (units N/m). For example, a short steel bolt with large area is very stiff (high k), meaning it takes a large P to produce a tiny δ. Conversely, a long slender rod is flexible (low k). In exam terms, you might compare which of two members stretches more by comparing $PL/(AE)$.

- **Typical values:** Metals have high E (steel ~200 GPa, aluminum ~70 GPa), so axial strains are on the order of micro-strain per MPa of stress. As a benchmark, a 1 m long steel bar under 10 kN (about 1-ton force) with cross-section 1 cm² (0.0001 m²) experiences $\delta = \frac{10000\ \text{N}\cdot 1\ \text{m}}{1e{-}4\ \text{m}^2 \cdot 200e9\ \text{Pa}} = 5e-5$ m $= 0.05$ mm. Very small! This illustrates why structural deflections in axial members are usually tiny – unless A is very small (like a thin wire) or L is huge (like a cable).

- **Elongation vs. contraction sign convention:** Taking tension as positive, δ comes out positive for a tensile P (elongation) and negative for a compressive P (shortening). The magnitude formula is the same; just be mindful in a problem if they ask "how much it shortens" under compression, you might give a positive number for the amount of shortening. The exam is typically clear by context, focusing on the magnitude of deformation.

Special notes (calculator usage): This formula is straightforward to compute. Just remember to group the numerator and denominator properly: on a scientific calculator you might compute $P \times L$ then divide by $(A \times E)$. Many exam-allowed calculators let you input the expression exactly as given. **Avoid rounding too early.** For instance, if E is 200 GPa and you convert to 2.00×10^{11} Pa, keep enough significant figures throughout to not lose precision in the final δ, which might be small. Also, if you get a very small number (like 5×10^{-5} m), don't panic – it's normal for metal stretches to be in the sub-millimeter range. Just express it in a sensible unit (e.g. 0.05 mm) if needed. Finally, if a temperature change is involved, you might need to compute two terms ($PL/(AE)$ and $\alpha \Delta T L$) – it's wise to compute each separately and then add, to minimize mistakes.

Explanation (in plain terms): The axial deformation formula $\delta = PL/(AE)$ is essentially telling us how *stretchy* a member is. Think of the member as a linear spring – AE/L acts like the spring constant. If you double the force P, you double the stretch δ. If you double the length L (a longer spring), you double the stretch. If you double the area A or the material stiffness E, you *halve* the stretch (a thicker or stiffer spring is harder to stretch). This principle shows up whenever you have rods, bolts, columns, etc., under load. On the FE exam, a classic scenario is: *"Given a steel rod of length X and diameter Y carrying a tensile load Z, how much does it elongate (within elastic range)?"* You identify it as an axial load problem and apply this formula. Another scenario: *thermal fit problems*, e.g. a metal pin is cooled and inserted, then warms up – you might use $\alpha \Delta T L$ to find how much it expands to lock in place (though in such cases stress would also develop if constrained). The concept is straightforward – load a member axially, and it changes length by an amount proportional to load and length. It matters because even small deformations can affect alignments in machines or cause stress redistribution in structures. Engineers use this to ensure deformations won't be excessive or to design allowances (like gaps for thermal expansion).

Analysis (step-by-step use and insights): Let's dissect $\delta = \frac{PL}{AE}$ term by term:

- P: The load. A larger axial force obviously causes more deformation. This is linear – if you triple P, you get triple the δ. Intuitively, pull harder, it stretches more. No surprise there.

- L: The initial length. A longer bar will experience more total elongation because the strain (stretch per unit length) accumulates over a greater length. If you have two identical rods but one is twice as long, under the same stress it will end up stretching twice as much overall. This is why long cables or tendons show noticeable stretch even under moderate tension.

- A: The cross-sectional area. This is inversely related because for a given force, a larger area means less stress ($\sigma = P/A$). Less stress means less strain ($\epsilon = \sigma/E$) and thus less elongation. Think of A as spreading the load – a thick rope barely feels a given force (small σ) whereas a thin string under the same force is highly stressed and elongates more. For example, pulling on a thin wire will noticeably lengthen it, but pulling on a solid rod with 10 times the cross-sectional area, you might not even detect the stretch without instruments.

- E: Young's modulus of the material. This is a material stiffness property – higher E (like steel ~200 GPa) means the material is "stiffer," so it deforms less for the same stress. A rubber-like material (low E) would stretch a lot more under the same stress. $1/E$ is like the material's compliance. On the exam, E will typically be provided (or a standard value for common materials). Ensure you use the correct E for the material in question (don't use steel's E for an aluminum rod, for instance – aluminum's E is about 70 GPa, so it will deform ~3 times more than steel under the same conditions).

- **Combining factors:** All together, $\frac{P}{A}$ gives the stress, $\frac{P}{AE}$ gives the strain (since $\epsilon = \sigma/E$), and multiplying by L yields the total deformation. Remember that strain $\epsilon = \delta/L$ is typically a very small number (like 0.001), meaning a 0.1% elongation for a metal under a few tens of MPa of stress. That fraction times the original length gives the actual extension.

- **Sign and direction:** If P is tensile (pulling), the bar elongates (we'd call that positive δ in the direction of P). If P is compressive (pushing in), the bar shortens (negative δ if we take extension as positive). In practice, you might just compute the magnitude and then say "shortens by X" to indicate a decrease in length. Be cautious: buckling is a separate phenomenon for long slender compressive members – this formula still gives the *shortening* up to the onset of buckling, but the exam would treat buckling (instability) as a different topic.

- **Physical feeling:** If you could hang on that rod, how much would it stretch? Often it's imperceptible, but the numbers show it's there. A quick mental check: a 1 m steel rod, 1 cm² area, under 1000 N (about 100 kg weight) stretches $\delta = 10001/(0.0001200e9) \approx 0.00005$ m $= 0.05$ mm. That's about the thickness of a hair – tiny! The FE problems might use more dramatic numbers or softer materials to get a more noticeable result (or just expect you to give it in scientific notation or mm). If you ever get a **huge** deformation from this formula (like centimeters on a short metal rod), double-check if the load or units were extremely large, or if perhaps the material wasn't typical (maybe it was plastic or something with lower E).

- **Hooke's law connection:** This formula is essentially the integrated form of Hooke's law. Hooke's law for a tension rod is $\sigma = E\epsilon$. Solving for ϵ gives $\epsilon = P/(AE)$. And since $\epsilon = \delta/L$, multiply both sides by L: $\delta = \frac{PL}{AE}$. So it's nothing magical – it's just the material's stress-strain response applied to the entire rod. Keep that in mind: if anything in the setup violates Hooke's law (like nonlinear material or temperature effects, etc.), adjustments are needed. But for exam purposes, unless they hint at plasticity or nonlinear behavior, you can safely apply this linear formula.

- **Thermal expansion synergy:** If the rod from the above example also heated up by 50°C and was free to expand, it would get an additional $\delta_t \approx 1.2$ mm (as we calculated). That would actually dwarf the mechanical stretch from 1000 N! So thermal deformations can be quite significant relative to mechanical ones, especially for metals under moderate loads. Keep an eye on whether a problem is dominated by mechanical or thermal strain. The exam might test that understanding by combining them or by having you compare which effect is larger.

- **Real-world tip:** In engineering design, axial deformations can affect things like preload in bolts (stretched bolts act like springs clamping parts) or sag in cables. But often axial deflection is of less concern than, say, beam deflection – except in cases like long pipelines (thermal expansion) or tall buildings (column shortening under load). The FE exam keeps it basic: straightforward application of $\delta = PL/(AE)$ and $\delta = \alpha \Delta T L$. Just be sure to identify when to use each and watch the units and sign.

K08.T09.S02 – Torsional Deformations (Angle of Twist in Shafts)

Principle introduction: When a structural member (typically a shaft) is subjected to a **torque or twisting moment**, it undergoes a **torsional deformation** – one end rotates relative to the other. Key points for torsion in circular shafts (the common case on the FE exam) include:

- **Angle of twist (ϕ)**: This is the angular twist (in radians) between the two ends of the shaft caused by the applied torque. It increases with torque T and shaft length L, and decreases with the shaft's torsional stiffness GJ. Essentially, $\phi = \frac{TL}{GJ}$ for uniform shafts.
- **Shear strain** occurs in the material: the outer surface twists the most. The shear strain at radius r is $\gamma(r) = \frac{r\,\phi}{L}$ (linear from zero at center to max at outer radius). The associated shear stress is $\tau(r) = G\,\gamma(r)$, giving $\tau_{\max} = G\gamma_{\max} = \frac{Tr_{\max}}{J}$ at the surface – but for deformation, we focus on ϕ.
- **Polar moment of inertia (J)**: This geometric property of the cross-section represents resistance to torsion (analogous to area A in axial loading or moment of inertia I in bending). For a solid circle, $J = \frac{\pi d^4}{32}$; for a hollow tube, $J = \frac{\pi(d_o^4 - d_i^4)}{32}$. A larger J (fatter shaft or material distributed far from center) means less twist for the same torque.
- **Shear modulus (G)**: Material property for shear stiffness (for example, steel's $G \approx 75$ GPa). It's related to E by $G = \frac{E}{2(1+\nu)}$, but usually G is given or one can compute it if ν (Poisson's ratio) is known. A higher $G \rightarrow$ shaft resists twisting more (smaller ϕ).
- Torsional deflection matters in **power transmission** shafts: e.g., how much twist occurs along a driveshaft at a given torque. On the exam, you might be asked to find the angle of twist in a shaft connecting two components, or how much a shaft will wind up under a motor's torque. Usually it's a plug-in into $\phi = TL/(GJ)$. Make sure to

use radians for ϕ in calculations (and convert to degrees if asked).

- Assumptions: These formulas assume the shaft is **circular (so it's in pure torsion)** and remains elastic. Non-circular sections (like rectangular shafts) have more complex behavior (warping, etc.), but those are beyond FE scope unless they give J and treat it similarly. We'll stick to circular shafts where $T/J = G\theta/L$ relationships hold nicely.

Exam Handbook Search Cues (Not affiliated with or endorsed by NCEES): *torsion, angle of twist, torsional stiffness* (to find the torsion formulas or relationships in the reference handbook if needed, such as J formulas or the twist equation).

Equation Passport – Angle of Twist (Torsion Formula)
Name and purpose: Angle of twist formula – calculates the rotational deformation (twist angle ϕ) of a circular shaft under a torque. It tells us how much one end of the shaft will rotate relative to the other due to the applied twisting moment, assuming elastic behavior.

Equation:

$$\phi = \frac{T\,L}{G\,J}$$

(For a uniform circular shaft. ϕ will be in radians.)

Variables and units:

- ϕ – **angle of twist** between the two ends of the shaft, in **radians** (rad). (Convert to degrees by $\phi_{\text{deg}} = \phi \times \frac{180^\circ}{\pi}$ if needed for an answer. A small twist might be given in degrees or minutes of arc on the exam.)
- T – **torque** (twisting moment) applied to the shaft, e.g. in **Newton-meters (N·m)** or **pound-feet (lbf·ft)**. Sometimes denoted M_t as well.
- L – **length** of the shaft (distance between the sections being considered, usually the full length if one end is fixed and torque applied at the other), in **m** or **ft (or in)**.
- G – **shear modulus** of the material, in **Pa (N/m²)** or **psi**. This is the modulus of rigidity, e.g. $G \approx 75$–80 GPa for steel.
- J – **polar moment of inertia** of the shaft's cross-section, in **m⁴** or **in⁴**. For a solid circular shaft of diameter d, $J = \frac{\pi d^4}{32}$ (SI units: m⁴). For a hollow shaft, $J = \frac{\pi}{32}\left(d_o^4 - d_i^4\right)$. The exam may provide J or the diameters to compute it. Units note: if d is in mm, be careful to convert to m for J in m⁴ (1 mm = 0.001 m; d^4 in mm⁴ needs a $(10^{-3})^4 = 10^{-12}$ factor to get m⁴).

Assumptions and scope:

- **Linear elastic, pure torsion:** The material obeys $\tau = G\gamma$ (Hooke's law in shear) and the cross-section remains plane (no warping for circular shafts). The formula assumes the shaft is elastic (no yielding due to torsion). - **Uniform shaft:** G and J are constant along the length (the shaft has the same material and cross-section throughout). If the shaft has sections of different diameter or material, you would apply this formula to each segment and sum the twists (angles add up) – analogous to springs in series.

- **Circular cross-section:** This formula is exact for circular shafts. Non-circular members (like square shafts) have a different stiffness and warping effects, but the FE exam generally sticks to circular or provides the needed info. We assume the cross-section is polar symmetric so that J fully characterizes torsional stiffness.

- **Small deformations:** ϕ is assumed small (in radians) such that the geometry doesn't drastically change and linear superposition holds. In practice, even a few degrees of twist over a long shaft is small strain (shear strain = $\phi \times (\text{radius})/L$ is usually tiny).

Limit tests (sanity checks): If $T \to 0$, then $\phi \to 0$ (no torque, no twist – correct). If the shaft is very short ($L \to 0$), $\phi \to 0$ (a stubby shaft barely twists because there's little length to deform). If G or J are huge (super stiff material or very thick shaft), ϕ is extremely small (as expected – a thick steel bar resists twist, whereas a thin rod or rubber shaft would twist a lot). If you double the torque T, the angle ϕ doubles – linear behavior. Also, check units: say $T = 100$ N·m, $L = 1$ m, $G = 80 \times 10^9$ Pa, $J = 1 \times 10^{-6}$ m⁴ (a typical small shaft). Then $\phi = \frac{1001}{80e91e-6} = \frac{100}{80e3} \approx 1.25 \times 10^{-3}$ radians $\approx 0.072^\circ$. That's a plausible small angle. If you got something like 50 radians for a modest torque, likely a unit error occurred. One common unit slip: using T in N·mm with L in mm and G in Pa (N/m²) *without* converting – always convert to consistent units (e.g., N and m) to get ϕ in rad. [^3]

Use vs. sibling equations: Use $\phi = \frac{TL}{GJ}$ for **torque-induced twist** of a shaft. It's the rotational analog of $\delta = \frac{PL}{AE}$ for axial deformation – in fact, the form is very similar, just P replaced by T and AE replaced by GJ. If you have a composite shaft (segments in series), calculate each segment's $\phi_i = TL_i/(G_iJ_i)$ and then total twist $\phi_{\text{total}} = \sum \phi_i$ (because each segment contributes to the overall twist). Do not confuse J here (polar moment) with second moment of area I used in bending deflection – they are different properties (though analogous in role). If the problem involves **angle of twist per unit length**, you might use $\theta = \phi/L = T/(GJ)$ (radians per meter). And if they ask for **torsional stiffness** of the shaft, that's $k_{\text{torsion}} = \frac{T}{\phi} = \frac{GJ}{L}$, which is like the spring constant in torsion (units N·m per rad). Use this equation instead of bending formulas or axial formulas – each type of deformation has its own expression. For a **non-circular cross-section** (like a rectangular bar in torsion), the exam would likely give an equivalent J or an empirical formula – you'd still use $\phi = TL/(GJ)$ if you treat that J as given. If the material yields (torsional yielding), then one would need plastic torsion analysis, which is beyond the simple linear formula scope (and beyond FE unless specifically mentioned).

Common exam traps:

- **Degree vs radian:** Perhaps the #1 trap – forgetting that ϕ in the formula comes out in radians. If a question asks "how many degrees of twist," you need to convert. For example, if you compute $\phi = 0.05$ (radians), the answer in degrees is $0.05 \times 180/\pi \approx 2.87^\circ$. If you mistakenly treat the radian result as degrees, you'd be off by a factor of 57! Always multiply by $180/\pi$ to go to degrees if required. Conversely, if given a twist angle in degrees and plugging back in, convert to rad for calculations.

- **Mixing up J and I:** J (polar moment) for torsion and I (area moment) for bending are analogous but not the same. A common error is using the wrong formula for J. Remember for a solid round shaft: $J = \frac{\pi d^4}{32}$ (note the 32, not 64; $\frac{\pi d^4}{64}$ is the area moment I for bending about one axis). If you accidentally use I instead of J, your calculated twist will be off (specifically, you'd be underestimating J for a circle by half, leading to double the twist). For a hollow shaft, ensure you use the polar version as well.

- **Units in G and J:** Often G might be given in GPa and diameters in mm. If you plug numbers blindly: say $G = 80$ GPa, J computed in mm⁴, L in mm, T in N·m – you will get a nonsensical result.

Convert all to consistent units. A good practice: convert G to Pa (N/m²), J to m⁴, L to m, T to N·m. The result ϕ is unitless (rad). Or in U.S. units, use G in psi, J in in⁴, T in lbf·in, L in inches to get ϕ in radians. If J is tiny (like 10^{-9} m⁴ for a small diameter) and L is large, the numbers can span many orders of magnitude – watch your calculator's handling of scientific notation.

- **Multiple connected shafts:** If a problem has, for instance, two shafts in series (one attached to another, maybe different materials or sizes), don't forget that they share the same torque T (assuming series with no branches) but each will twist. You sum the twists for total angle. If shafts are in parallel (torque splitting between them), that's a more complex scenario (usually not in FE exam unless through a statics equilibrium problem). But series is common in "composite shaft" questions. Missing one segment's twist or using the wrong T (like splitting torque incorrectly when not needed) is a trap.

- **Using wrong formula for non-circular sections:** If the exam throws a curveball like a square bar in torsion, the formula $\phi = TL/(GJ)$ still holds if you know J (for a rectangle, polar moment $J = \int (x^2 + y^2)dA$ or they might give torsional constant J_t). If they instead give a formula like $\tau_{\max} = \frac{Tc}{J}$ and ask twist, stick to $\phi = TL/(GJ)$. The trap would be to misuse a pure stress formula when the asked quantity is deformation.

[^3]: *Units check for torsion:* Let's detail a unit consistency check. Suppose $T = 500$ lbf·ft, $L = 10$ ft, $J = 1.2$ in^4, $G = 11 \times 10^6$ psi (typical for steel, since $E \approx 30 \times 10^6$ psi and $\nu \approx 0.3$, $G \approx 11.5 \times 10^6$ psi). First, convert everything to consistent units: convert T to lbf·in (500 lbf·ft is 6000 lbf·in), L to inches (10 ft is 120 in), keep J in in⁴, G in psi (lbf/in²). Now plug in: $\phi = \frac{6000 \text{ lbf·in} \times 120 \text{ in}}{(11\times10^6 \text{ lbf/in}^2)(1.2 \text{ in}^4)}$. The units: lbf·in * in = lbf·in² in numerator; denominator: lbf/in² * in⁴ = lbf·in² (nice, they cancel). Numerically: $\phi = \frac{720000 \text{ lbf·in}^2}{13.2\times10^6 \text{ lbf·in}^2} = 5.45 \times 10^{-2}$ (dimensionless in radians). That's about $0.0545 \times (180/\pi) \approx 3.12°$. Always ensure the lbf and in units line up like that. In SI, as mentioned earlier, ensure N·m with m and Pa with m⁴ – do a similar cancellation check (N·m * m = N·m²; Pa * m⁴ = N/m² * m⁴ = N·m², cancels). If something doesn't cancel to dimensionless for ϕ, re-examine units.

Variations, related forms, typical values:

- **Angle of twist per unit length:** Sometimes it's useful to compute $\frac{\phi}{L} = \frac{T}{GJ}$, which has units of radian per meter (or per inch). This is the *rate of twist* along the shaft. If a problem says "determine the rotation in degrees per foot of shaft," you'd find ϕ/L and convert to deg/ft. A uniform shaft has constant ϕ/L along its length (it's linearly twisting evenly).

- **Segmented shafts:** If a shaft has portions with different diameters or materials (for example, a steel shaft coupled to an aluminum shaft in series, transmitting the same torque), calculate each segment's twist $\phi_i = TL_i/(G_iJ_i)$. The total twist from one end to the other is $\phi_{\text{total}} = \phi_1 + \phi_2 + \cdots$. In such cases, the stiffer segment (higher GJ/L ratio) will take a smaller portion of the total angle. This is analogous to springs in series where each spring stretches differently under a common load depending on stiffness.

- **Torsional stiffness (spring analogy):** The torsional stiffness of a shaft segment is $k_{\text{torsion}} = \frac{T}{\phi} = \frac{GJ}{L}$. So if you see a problem phrased like "find the effective spring constant of the shaft for torsional deflection," that's what they mean. For example, if $GJ = 10^6$ N·m² and $L = 1$ m, then $k = 10^6$ N·m per rad. If multiple shafts are in series, the equivalent stiffness is like springs in series: $\frac{1}{k_{\text{eq}}} = \frac{1}{k_1} + \frac{1}{k_2} + \cdots$ (but you could just add angles, as above). If in parallel (two identical shafts connecting the same flanges sharing torque), then stiffness adds ($k_{\text{eq}} = k_1 + k_2$) since each carries part of the torque for the same angle. Parallel torsion might be seen in something like a dual-shaft system or a thin tube with a rod inside it both taking torque.

- **Hollow vs solid shafts:** A neat insight: for equal weight, a hollow shaft can have a larger J than a solid one (because material is farther out). That's why drive shafts or drill shafts are often hollow tubes – they resist torsion better per unit weight. Typical J values: a solid 1-inch diameter rod has $J \approx 0.098$ in^4; a hollow tube 1-inch outer, 0.5-inch inner has $J \approx 0.079$ in^4 (less, but if you used the same material volume to make a larger diameter thin tube, J can improve). The exam could ask conceptually: "for the same material and weight, which cross-section gives least twist?" – answer: the one with largest J (which usually means hollow, larger diameter).

- **Typical twist magnitudes:** In real machines, designers often want to keep twist small (maybe under a degree or two in many applications) to avoid misalignment. For instance, a long 3 m steel shaft of 50 mm diameter under a torque of 2 kN·m: $J = \pi(0.05^4)/32 = 3.8e-8$ m⁴, $G \approx 80e9$ Pa, $L = 3$ m, $T = 2000$ N·m. $\phi = 20003/(80e93.8e-8) \approx 0.00197$ rad = 0.113°. Very small. If the shaft were only 20 mm diameter (much smaller J), twist would jump by factor (ratio of d^4) – roughly $(50/20)^4 = 39$ times more, about 4.4°. That would be noticeable. So, expect that "reasonable" twist angles in metals are usually small unless dealing with thin shafts or very high torque. Polymers or other low-shear-modulus materials could twist more for the same torque.

- **Torsion formulas for special cases:** While $\phi = TL/(GJ)$ is the primary formula, recall also related torsion formulas: $\tau_{\max} = \frac{Tc}{J}$ (max shear stress) and the linear variation of stress/strain with radius. If a question gives you angle of twist and asks for something like shear strain at the surface, you can get $\gamma_{\max} = \frac{c\,\phi}{L}$ or relate $\phi = \frac{\tau_{\max}L}{Gc}$. But likely, if deformation is the focus, they'll stick to the direct use of ϕ.
- **Elastic limit in torsion:** Just a note – if they ever ask how far you can twist before yielding, you'd use $\tau_{\max} = \frac{Tc}{J}$ with τ_y (shear yield) to find T_y, then find $\phi_y = T_yL/(GJ)$. The exam is unlikely to require that, but it shows the interplay: twist at yield is linear up to yield torque.

- **Multi-degree systems:** If a torsion problem is part of a bigger system (say a shaft connecting two disks, forming a torsional vibration system), the deformation formula still holds for static twist. For dynamic or vibration, you'd use torsional stiffness in spring-mass analogies. That might cross into dynamics/vibrations topics. But in pure mechanics of materials context, treat it statically.

Special notes (calculator tips): When calculating ϕ, perform the operations carefully: multiply T and L, divide by G, then divide by J. Due to potentially large or small numbers (e.g., G might be 80×10^9 and J might be 10^{-8}, leading to a product GJ on the order of 10^2 in SI), watch out for overflow/underflow in your calculator. It's wise to use scientific notation mentally: e.g., $TL = 2000 * 3 = 6000$ N·m²; $GJ = 80e9 * 3.8e-8 = 3.04e3$ N·m²; then $\phi = 6000/3.04e3 = 1.9737$ (which is 1.97×10^0) times $10^{-?}$? Actually we get ≈ 1.97 (no power of ten), which matches earlier. If

your calculator gives something like "5.7E1" rad, double-check the input units or if you accidentally used diameter instead of radius for J. Also, if converting ϕ to degrees, you might do that as a separate step to avoid any confusion. The allowed FE exam calculators have a π key and some have a degrees-radians mode – but generally, just multiply by 57.2958 to get degrees. For instance, $\phi = 0.02$ rad, times $57.3 = 1.146°$. Keep at least a few decimal places in intermediate steps to avoid rounding error in a small angle.

Explanation: The torsion formula $\phi = \frac{TL}{GJ}$ is basically telling us how a shaft behaves like a **rotational spring**. Think of twisting a rod: the more torque you apply, the more it twists (linearly so long as you don't yield it). A longer rod (bigger L) will twist more because there's more length over which the twist can accumulate – just like a longer spring stretches more under the same force. A stiffer material (higher G) or a shaft with more polar area (higher J) will twist less – they are harder to twist. This formula is fundamental in mechanical design: for example, in a car's drive shaft, you can calculate how much the shaft winds up when transmitting torque from the engine to the wheels. If it's too high, maybe you choose a thicker shaft or a material with a higher shear modulus. On the exam, a typical problem might say: *"A steel shaft of diameter X and length Y transmits Z N·m of torque. How many degrees of twist does it experience?"* You'd compute ϕ in radians and convert to degrees. Another might involve two shafts: *"A brass rod and a steel rod, same length, are connected end to end and subjected to a torque. Find the rotation of the free end."* You'd find each rod's twist and add them. We use this formula instead of doing complex integration because it's derived from the basic proportionality of shear strain: the derivation (for the curious) comes from integrating $\frac{d\phi}{dz} = \frac{T}{GJ}$ along dz – which directly yields $\phi = \int_0^L \frac{T}{GJ} dz = \frac{T}{GJ} L$ for constants. So it's grounded in the same Hooke's law idea but for shear. The reason it's neat for circular shafts is that the cross-section doesn't warp; each cross-section simply rotates relative to the next as if a stack of coins twisting.

In practical terms, you can imagine painting a straight line along the length of a cylindrical shaft. When you twist the shaft, that line will spiral – the angle it rotates from one end to the other is ϕ. Engineers check that ϕ is within acceptable limits for things like coupling alignment. If it's not, they'll stiffen the shaft (increase J by going to a larger diameter, or shorten L, or use material with higher G).

Analysis: Consider the formula's components and typical pitfalls: - Increasing the **torque** T linearly increases the twist. So two times the torque gives two times the angle. This is straightforward – it's a linear elastic response. If you have multiple torques applied along the shaft (say a shaft with a gear in the middle, torqued at two locations), then between those torque application points, the internal torque may differ. But usually FE problems keep it simple with one constant torque along the length or clear sections with constant internal torque. Always identify the internal torque diagram if needed (similar to how you'd find bending moment for a beam, but here in a shaft for torsion).

- **Length L:** A long shaft is much more compliant in torsion. For example, a screwdriver shaft that's very long will wind up more than a short stubby screwdriver. This is why sometimes you see long slender shafts twist visibly under load (like a long drill bit twisting when stuck). If the exam asks something conceptual like "Given two shafts of equal diameter and material, one twice as long as the other, how do their twist angles compare under the same torque?" – the answer: the longer one has double the angle of twist. It's linear with length.

- **Shear modulus G:** This is inherently tied to the material. If you replace a steel shaft with an aluminum shaft of the same dimensions under the same torque, the aluminum (with $G \approx 25$ GPa vs steel's ~75 GPa) will twist about three times more. So remember the material matters – E is for stretching, G is for twisting (and shearing). If only E is given, you might need ν to find G, but typically either they give G or assume a common ν if needed. For steel, an approximate G is $0.4E$ (since $\nu \approx 0.3$). For an exam question, if they forgot to give G for a typical material, you could recall $G_{steel} \approx 11.5 \times 10^6$ psi or 75–80 GPa. But usually it'll be provided.

- **Polar moment J:** This stands out because it has a strong effect (fourth power of diameter). If you slightly increase the diameter of a shaft, J skyrockets and the twist goes way down. For instance, going from a 20 mm diameter to 40 mm (2× diameter) increases J by $2^4 = 16$ times, so twist for the same T drops by 16. That's huge! So if you need to reduce twist, increasing diameter is extremely effective. On the flip side, a small reduction in diameter drastically increases twist. For exam problems, if a shaft diameter is given in an odd unit, ensure you compute J correctly.

Pro tip: sometimes it's faster to compute J in cm⁴ or mm⁴ then convert: e.g., $d = 100$ mm, $J = \frac{\pi(100)^4}{32} = 0.3068 \times 10^8$ mm^4 $= 3.068 \times 10^7$ mm^4. To convert to m⁴, note $(10^3 \text{ mm})^4 = 10^{12}$ mm^4 $= 1$ m^4, so divide by 10^{12}: $J = 3.068 \times 10^{-5}$ m^4. Keeping track of these powers is vital to avoid being off by factors of 10^6 or more in ϕ. Many wrong answers stem from unit conversion slip-ups.

- **Series vs parallel shafts:** If the problem had something like a composite shaft (steel core inside an aluminum tube, bonded so they share torque), that's a parallel situation: both materials share the torque according to their stiffness. The angle of twist is the same for both (since they're bonded) and $T = T_{steel} + T_{Al}$. Each carries torque in proportion to GJ. Such a problem would require solving two equations: $T_s + T_a = T_{total}$ and $\frac{T_s}{G_s J_s} = \frac{T_a}{G_a J_a}$ (equal twist). This is more complex but not unheard of in advanced mechanics classes – the FE might not go there unless giving a straightforward way to handle it. But it's good to recall that if asked "which section (core or tube) carries more torque?" – you'd say the one with greater GJ carries more because it's stiffer in torsion (like a stiffer spring takes more load in parallel).

- **Torsion vs bending analogy:** Not directly an analysis point, but conceptually: $\phi = TL/(GJ)$ parallels $\delta = PL/(AE)$. If you know one, you see the structure of the other. Likewise, torsional stiffness GJ/L parallels axial stiffness AE/L. It's useful to see these analogies because if you've solved a problem type in axial, you can adapt it to torsion by swapping these quantities. For example, two rods in series under tension share P and add elongations; two shafts in series under torsion share T and add twists. If you understand one, you can tackle the other by analogy.

- **Check extreme cases:** If someone asks, "What happens if you slit a shaft along its length (making it non-closed cross-section)?" The torsional stiffness plummets because J effectively becomes much smaller (for an open cross-section, torsion formula differs). But that's an aside to illustrate J must be for the full cross-section resisting torsion. The FE exam probably won't deal with open vs closed cross-section nuances except maybe conceptually (like why tubes are good).

- **Summing up:** To solve torsion deformation problems: identify the shaft or shafts carrying the torque, find the torque value (could

be given or from equilibrium of forces), compute or look up J, use the given G, and plug into $\phi = TL/(GJ)$. Then give the answer in requested units (likely degrees if they want a human-friendly number). Always reflect: does the magnitude make sense? A 2° twist over 10 ft in a steel shaft under a moderate torque is plausible. A 90° twist in the same scenario would be a red flag – maybe the shaft yielded or you did something wrong. The beauty of these mechanics formulas is you can often smell a wrong result by orders of magnitude, so trust your engineering sense.

K08.T09.S03 – Bending Deflections in Beams (Slope and Deflection of Beams)

Principle introduction: Beams under transverse loads (like weights or distributed loads) not only develop internal shear forces and bending moments, but also undergo **deflection (vertical displacement)** and **rotation (slope)** along their length. Key points for bending deflections:

- **Beam deflection** is governed by the beam's flexural stiffness EI (product of Young's modulus and the area moment of inertia of the cross-section about the bending axis) and the load distribution. Under load, a beam will curve – we usually denote the deflection as $y(x)$ (with y measured from the original straight position).
- The fundamental relationship for small deflections is $EI\frac{d^2y}{dx^2} = M(x)$, where $M(x)$ is the bending moment as a function of position. This comes from the curvature-moment relation (for an initially straight beam, $\kappa = \frac{1}{R} = \frac{M}{EI}$, and curvature κ is approximately d^2y/dx^2 for small slopes).
- By **integrating the moment equation**, you get the slope and deflection:
  $EI\frac{dy}{dx} = \int M(x)\ dx + C_1$ (slope angle's relation to area under moment curve),
  $EI\,y(x) = \int (\int M(x)\ dx)dx + C_1x + C_2$. The constants C_1 and C_2 are determined by boundary conditions (like $y = 0$ at a support, or $dy/dx = 0$ at a fixed end, etc.).
- **Boundary conditions & continuity**: For statically determinate beams, typical BCs are: at a pinned or roller support, deflection $y = 0$; at a fixed support, $y = 0$ and slope $dy/dx = 0$; at a free end (cantilever tip), usually $M = 0$ and $V = 0$, which translate to slope or curvature conditions (for a cantilever: at the free end, $M = 0$ implies $y'' = 0$ there, and $V = 0$ implies $y''' = 0$ there if you go further, but often just using $M = 0$ and $V = 0$ gets the integration constants).
- **Superposition** is very handy: Because the governing equation is linear, the deflection due to multiple loads is the sum of deflections due to each load independently. This means we can use known formulae for simple load cases and add them for combined cases (provided we're in the elastic small-deflection regime).
- For the FE exam, you are *not* expected to derive complex deflection formulas from scratch in most cases – rather, you either recall common results (they sometimes list a few common cases in the handbook, like simply supported or cantilever formulas) or you set up a quick integration for a simple polynomial moment diagram. **Common deflection formulas** you might use:
- *Cantilever beam:* max deflection under a tip load P is $\delta_{\max} = \frac{PL^3}{3EI}$ (downwards at the free end); slope at free end $\theta_{\max} = \frac{PL^2}{2EI}$. For a uniform distributed load w on a cantilever, $\delta_{\max} = \frac{wL^4}{8EI}$ at tip, and slope at tip $\theta_{\max} = \frac{wL^3}{6EI}$.
- *Simply supported beam:* max deflection for a concentrated mid-span load P is $\delta_{\max} = \frac{PL^3}{48EI}$ at mid-span; for a uniform load w over entire span, $\delta_{\max} = \frac{5wL^4}{384EI}$ at mid-span. Slope at supports for a simply supported with mid load is $\theta_{\text{support}} = \frac{PL^2}{16EI}$ (rotating outward), etc.
- These numbers are worth remembering or deriving quickly because they appear often. They show how sensitive deflection is to span length (L^3 or L^4 powers!).
- **Slope (θ)**: dy/dx gives the angle (in radians) the beam's deflected shape makes with the horizontal. At supports, slope might be zero if fixed or some value if free to rotate. Sometimes an exam question may ask for slope at a point (less common but possible).
- **Units**: If using SI, M in N·m, x in m, E in Pa, I in m⁴, then $EIy'' = M$ yields y in m (since M/EI has units 1/m, integrating twice yields length). In US units, use consistent units (e.g., M in lb·in, E in psi, I in in⁴, x in in, result y in inches).
- Always consider the **shape of deflected curve**: sign conventions aside, you know a beam loaded will sag. If you get a deflection with a wrong sign, check your coordinate assumption (generally, assuming downward deflection as negative y is common in deriving formulas, but the magnitude is what matters in most answers).
- **Small deflection theory**: This assumes the deflection is small compared to length (which is usually true at elastic loads, deflections are maybe a few mm in a several-meter beam). Under this assumption, $1/\rho \approx d^2y/dx^2$ (curvature equals second derivative, neglecting slope squared terms), which the formula uses.

Exam Handbook Search Cues (Not affiliated with or endorsed by NCEES): *deflection of beams, beam formulas, slope, double integration, superposition* (these terms can help find beam deflection entries or tables in the handbook; e.g. searching "deflection" or "cantilever" might pull up common case formulas).

Equation Passport – Beam Deflection by Integration
Name and purpose: Euler-Bernoulli Beam Deflection Equation – relates the bending moment in a beam to its curvature and, upon integration, to the slope and deflection. It provides a method to determine the deflected shape $y(x)$ of a beam under loading. Essentially, it's the "formula" that governs all beam deflections, from which specific case formulas are derived.

Equation:

$$EI\,\frac{d^2y}{dx^2} \;=\; M(x)$$

This differential equation states that the bending stiffness EI times the beam's curvature (d^2y/dx^2) equals the bending moment at that section. Integrating it yields slope and deflection:

$$\frac{dy}{dx} \;=\; \frac{1}{EI}\int M(x)\ dx + C_1$$

$$y(x) \;=\; \frac{1}{EI}\int\left[\int M(x)\ dx\right]dx + C_1x + C_2$$

(Often we skip writing the explicit integrals in solutions and use known $M(x)$ piecewise or known results. But this is the general formula.)

Variables and units:

- $y(x)$ – **deflection** of the beam as a function of position x (usually measured from one end), in **meters (m)** or **inches (in)**. y is typically taken positive in the direction of the applied load's displacement (often downwards for gravity loads, though sign convention can vary).

- x – **longitudinal coordinate** along the beam's length, in **m** or **in**. We integrate with respect to x.

- $\frac{d^2y}{dx^2}$ – **curvature** of the deflected beam (approximately, for small deflection, the second derivative of deflection), in units of **1/m** (if y in m and x in m). It's positive when the beam is bent concave-up in our coordinate system convention (depending on sign of M convention).

- $M(x)$ – **bending moment** at position x, in **N·m** or **lb·in** (etc.). This is obtained from static equilibrium (shear and moment diagrams). It can be a function of x (e.g., triangular distribution along the beam). Plug it into the equation to integrate.
- E – **Young's modulus** of the beam material, in **Pa (N/m²)** or **psi**. Higher E (stiffer material) means less curvature for a given moment.

- I – **area moment of inertia** of the beam's cross-section about the neutral axis (the axis of bending), in **m⁴** or **in⁴**. A larger I (e.g., taller or wider cross-section) means the beam is harder to bend (less deflection). This is *not* the same as polar J from torsion; here I might be $bh^3/12$ for a rectangle, etc., depending on orientation.

Assumptions and scope:

- **Small deflections, linear elasticity:** The derivation assumes deflections are small enough that the geometry doesn't change significantly (so we can use the original beam geometry to calculate M and use $y'' \approx M/EI$). Also, material remains linear elastic (so E is constant and valid). No yielding or material nonlinearity.

- **Constant EI (if taken outside integrals):** Often we assume E and I are constant along the beam (homogeneous material, prismatic section). If they vary (e.g., a tapered or stepped beam), you either integrate carefully with $EI(x)$ inside or break into pieces. Most exam problems stick to constant EI for simplicity.

- **Planar bending of slender beams:** Euler-Bernoulli theory neglects shear deformation (okay for slender beams with length >> depth). For very deep beams or sandwich structures, shear deformation (Timoshenko beam theory) can contribute, but not in FE exam context usually. So we assume deflection is due purely to bending curvature.

- **One-dimensional behavior:** The beam is straight initially and deflects in one plane. Torsion or lateral buckling aren't considered here (they belong elsewhere). If multiple loads or types (axial + bending), superposition can still work if the problems decouple, but strictly this formula is for bending deflection due to bending moments.

- **Boundary conditions applied after integration:** To get the integration constants C_1, C_2, we apply conditions like $y = 0$ at a pinned support, $dy/dx = 0$ at a fixed support, or symmetry conditions (slope 0 at midspan of a symmetric load case, etc.). This is crucial for solving specific problems.

Limit tests (sanity checks): If no bending moment ($M(x) = 0$ everywhere, meaning no load or just axial load with no eccentricity), then $y'' = 0$. Integrating, $y' = C_1$ (constant slope) and $y = C_1x + C_2$ which is a straight line – the beam doesn't curve, which makes sense (it might displace as a rigid body if not constrained, but with supports it'd just stay flat with no load). If EI is extremely large (rigid beam), the equation implies for a given M, y'' is near zero – i.e. almost no curvature, which fits intuition that a super stiff beam won't deflect much under load. The higher the moment $M(x)$, the larger the curvature y'' – if you put a big load, you expect a big bend. Dimensionally, check a simple case: a simply supported beam, midspan load P. We know by symmetry $M(x)$ is triangular, with $M_{\max} = PL/4$ at midspan. Solving δ_{max} we gave earlier yields something proportional to $PL^3/(EI)$. So plugging in units: $N \cdot m * m^3/(N/m^2 * m^4) = (N \cdot m^4)/(N \cdot m^4) = 1$, unitless, but actually that 1 in this dimensional analysis corresponds to meters (because we ended up with something in the numerator and denominator that cancels out leaving m). In other words, everything is consistent. Another check: if you halve the span L, deflection should drop quite dramatically (since L^3 or L^4 in formulas) – the math shows that. If you increase I by factor 10 (say choose a much deeper beam), deflection goes down by factor 10 – good. So the formula's implications align with engineering expectations: stiffer (higher EI) means less deflection; longer span or heavier load means more deflection. Always double-check if your computed deflection seems off by an order of magnitude – maybe a units problem (mixing mm and m in I perhaps).

Use vs. sibling equations: Use the beam deflection equations for calculating **transverse displacements** of beams under lateral loads. They are distinct from axial $\delta = PL/AE$ (which gives longitudinal extension, not bending deflection) and from torsional $\phi = TL/GJ$. If a problem involves a frame or combined loading, you might need to use these in conjunction with other deformations. For example, sometimes a frame deflection is due to bending in one member and axial deformation in another – you'd compute each part accordingly (bending for the beam part, axial for the column part, etc.). Also, note the **Principle of Superposition**: use this equation or known solutions for each load case and sum the deflections. If you have a table of beam formulas (like deflections for various cases), *use them* rather than re-derive under exam time constraints. The official handbook often provides a few common cases. Use superposition instead of solving a differential equation when multiple loads are present – for example, for a point load plus a uniform load on the same beam, you can add the deflection from each load alone. Don't confuse these elastic formulas with *buckling formulas* (which also produce deflection, but in instability context) – buckling (column critical load) is another topic; here we assume loads are below buckling so beam just bends normally. Also, differentiate between **statically determinate** vs **indeterminate**: for indeterminate beams (fixed ends, multiple supports), you might still use superposition or known solutions (like fixed-end beam deflection formulas). Indeterminate cases require satisfying compatibility (which essentially is using deflection conditions to solve extra reactions). The exam might provide fixed-end moments or expect you to recall that a fixed-fixed beam has less deflection (e.g., midpoint deflection for a fixed-fixed with uniform load is $5wL^4/(384EI)$ which is half of simple span's $5/384$ result due to fixity, actually for fixed-fixed with full UDL it's $wL^4/(384EI)$ for central deflection – much smaller). Use whatever references you have or memory for such cases.

Common exam traps:

- **Using wrong formula or forgetting to square something:** There are many beam deflection formulas and it's easy to mix them up if memorized by rote. For example, confusing the $PL^3/(48EI)$ (simply supported mid-load) with $PL^3/(3EI)$ (cantilever) is dangerous. A way to avoid this is derive quickly via integration if unsure, or check boundary conditions: e.g., a simply supported beam's deflection should be zero at supports – any formula you use should satisfy that at $x = 0$ and $x = L$. If it doesn't, it's the wrong one. Or use symmetry if applicable.

- **Sign convention in integration:** When you integrate $M(x)$, if you set up $M(x)$ with a sign (say taking sagging moments as positive producing concave up deflection), you have to be consistent. Getting the sign wrong could lead to a deflection equation that has the wrong curvature direction. Usually, we care about magnitude of deflection (which is positive as a number), but if the problem expects a direction (like "downward 5 mm"), a sign error might lead you to say upward. To avoid sign confusion, often we take downward deflection as positive just for ease, or we derive using the bending moment with its sign and know a positive M (sagging) yields a deflection that is usually downward for a beam loaded from above. In short: keep track of which way is positive y. If using the handbook's formulas, follow their convention.

- **Forgetting boundary conditions (integration constants):** If you do the integration method, not applying BCs correctly will give an incorrect deflected shape or wrong constants. A classic mistake is forgetting that at a free end of a cantilever, the moment is zero which means $y'' = 0$ there, which provides one condition for the second integration. Or forgetting that at a midspan of a symmetric load the slope is zero (a symmetry condition that can simplify problems). Always use all given/support conditions to solve for C_1, C_2.

- **Mixing units in w, P, E, I:** Just like earlier topics – if w (distributed load) is given in, say, kN/m, and L in m, E in GPa, I in cm⁴, you must convert everything to a consistent set. A common slip: using I in cm⁴ or mm⁴ without converting to m⁴ when E is in Pa (which is N/m²). That will throw your deflection off by factors of 10^8 or 10^{12}. For instance, $I = 3000\ \text{cm}^4 = 3 \times 10^7\ \text{mm}^4 = 3 \times 10^{-5}\ \text{m}^4$ – missing that conversion will mess up results big time. Similarly, if you get a deflection like 2.5×10^{-6} and the answers are given in mm, convert it: that's 0.0025 mm – don't just say 2.5×10^{-6} m without context. The exam may have you choose an answer closest to, say, "0.0025 mm" and if you didn't convert you might misidentify it.

- **Ignoring beam self-weight if significant:** Occasionally, a problem might implicitly include the weight of the beam as a distributed load (especially if it says "a uniform beam of weight W" or gives density). If not explicitly stated, don't overcomplicate – but be mindful if it's implied. Usually, exam problems will specify all loads.

- **Applying superposition outside linear range:** Superposition only works in the elastic linear regime (which is our assumption). If something were large deflection or plastic, superposition fails. But FE problems won't venture there without clear indication.

- **Indeterminate beam missteps:** If confronted with a fixed-end or multiple-span beam, you might recall deflection formulas or do superposition by adding a redundant load to enforce a condition. A trap is to forget that a fixed support has zero slope as well – double condition – which is why fixed beams develop fixed-end moments to satisfy that. If they ask for deflection of a fixed-fixed beam under load, the naive simply-supported formula will overestimate it. The exam might directly give a formula or expect you to know qualitatively that fixed supports reduce deflection (perhaps by a factor of 4 for midpoint deflection in some cases). Don't apply simple span formulas to a fixed span scenario.

Variations, related forms, typical values:

- **Common case formulas:** It's worth summarizing a few highly useful ones (assuming uniform EI):

- *Cantilever beam with point load P at free end:* $y(x) = \frac{Px^2}{6EI}(3L - x)$ for $0 \le x \le L$. At the free end ($x = L$), $\delta_{\max} = \frac{PL^3}{3EI}$ (downward). Slope at free end $\theta(L) = \frac{PL^2}{2EI}$. At the fixed end ($x = 0$), $y(0) = 0$, $\theta(0) = 0$ as expected.

- *Cantilever with uniform load w (force per length, downward):* $y(x) = \frac{wx^2}{24EI}(6L^2 - 4Lx + x^2)$. Maximum at tip $x = L$: $\delta_{\max} = \frac{wL^4}{8EI}$. Slope at tip $\theta(L) = \frac{wL^3}{6EI}$. (These are larger relative to point load case, because distribution adds more bending energy).

- *Simply supported beam with point load P at midspan:* Deflection shape is piecewise cubic. Maximum at mid ($x = L/2$) as given: $\delta_{\max} = \frac{PL^3}{48EI}$. The equation: for $0 \le x \le L/2$, $y(x) = \frac{Px^2(3L-4x)}{48EI}$ (and symmetric for the other half). Slope at support: $\theta(0) = \frac{PL^2}{16EI}$ (rotating outward, radian).

- *Simply supported with uniform load w over full span:* $y(x) = \frac{wx}{24EI}(L^3 - 2L^2x + x^3)$ for $0 \le x \le L$ (symmetric about mid). Max at mid: $\delta_{\max} = \frac{5wL^4}{384EI}$. Slope at support: $\theta(0) = \frac{wL^3}{24EI}$.

- *Overhanging, fixed, etc.:* Many other cases exist (e.g., fixed-fixed with uniform w: $\delta_{\max} = \frac{wL^4}{384EI}$ at mid, much smaller due to fixity; fixed-fixed with symmetric point load, etc.). The exam might not expect memorization of those; they could be derived or sometimes provided in handbook references.

- If you have these baseline cases in mind, you can mix them: e.g., if you have a beam with both a mid-point load and a uniform load, deflection = (that from point) + (that from uniform). Or if a non-mid load, you can break into segments or use the more general formulas, but often exam loads are at nice locations like mid or uniformly distributed.

- **Double integration strategy:** If you forget a formula, you can always derive quickly for simple $M(x)$. For example, for a simply supported beam with a point load not at mid (say at a distance a from left), you'd write expressions for $M(x)$ on left and right of load (piecewise linear diagrams), integrate each piece with proper constants, and apply BCs $y(0) = 0, y(L) = 0, y$ continuous at load, slope discontinuity at load's location equals angle from moment jump (but for a concentrated load, shear jumps, moment slope changes, etc.). That's a bit heavy; usually better to memorize or consult references for those. But *if* needed, remember to treat each region separately and match deflection and slope at the load.

- **Energy methods:** An alternative not often needed explicitly but powerful: Castigliano's theorem. It states deflection at a point = $\partial U / \partial P$ (where U is strain energy, P external force at that point). It yields the same results and can handle complicated structures. For instance, if an indeterminate problem was given, one might use Castigliano. However, FE exam problems on deflection are usually

straightforward enough to not require heavy artillery like that – still, if you like, note that strain energy in a beam $U = \int_0^L \frac{M^2}{2EI} dx$, so $\partial U / \partial P$ at an applied P gives deflection at that force's app point. In any case, know that approach exists as a variation.

- **Deflection limits:** In design, codes often specify allowable deflection ratios (like max deflection = L/360 for a floor beam under live load, etc.). While the FE won't quiz code numbers, an understanding that a deflection of say 3 inches in a 10 ft span (L=120 in, deflection 3 in gives ratio 1/40) is quite large and likely unacceptable, whereas 0.3 in (L/400) is fine, is good engineering sense. On a multiple-choice exam, if one answer stands out as unreasonably large deflection relative to span, it's likely wrong (assuming an elastic scenario).

- **Slope significance:** Slope is usually in radians. A slope of 0.1 rad ~ 5.7°. At supports, slopes tell how much the beam ends rotate – if too high, maybe pins have issues etc. On FE, slope might be asked for at a support or free end. It's often a byproduct of your deflection equation derivative. Just remember to give in rad or convert to degrees if needed.

- **Continuity and compatibility:** In indeterminate structures, deflection compatibility is used (like setting deflection at a point to zero or equal slopes where needed). For example, a prop at mid-span effectively adds a reaction such that deflection at that point is zero – you'd solve for that reaction by imposing $y(mid) = 0$. That is a variation of the usage of these equations: solving unknown reactions by requiring a deflection condition. This is more structural analysis territory, but since it uses the deflection formula, it could appear. E.g., *"A simply supported beam with an interior prop (third support) under uniform load: find reaction at prop."* Use deflection of simple span to find how much it would deflect at prop location without prop, set that equal to the prop's deflection (zero if assuming prop gives just enough reaction to prevent movement), solve reaction via proportion to needed counter-bending moment, etc. That's a bit advanced, but manageable with superposition (remove prop, get deflection, then apply upward force at prop location to cancel it, using superposition and solve that force).

- **Transverse shear deflection:** At very high loads or very short beams, shear deformation might contribute (deflection due to shear is $\delta_{\text{shear}} = \frac{VL}{AGk}$ for some k factor, where V is shear). For most metal beams, bending deflection dominates. The FE Reference might mention shear deflection formula for completeness, but typical problems neglect it. However, if you had a very deep short beam or a material with low shear modulus (like a foam or wood), shear deflection could be non-negligible. Unless prompted, you can assume pure bending deflection alone.

Special notes (calculator and approach): If using formulas, plug numbers carefully, especially with those big powers of L. It's easy to make an arithmetic mistake when say L^4 is involved. Use your calculator's parentheses and exponent function: e.g., if $L = 5$ m and formula calls for L^4, compute $5^4 = 625$ m⁴. Then multiply by other terms. If doing integration during the exam: label your integration constants clearly and solve step by step (it's easy to lose a constant or get signs mixed under pressure). Sometimes it helps to reduce a problem by symmetry – e.g., for a symmetric load on a symmetric span, you know slope 0 at mid, so you can integrate from one end to mid with that condition instead of from 0 to L with multiple conditions. When dealing with large EI, consider factoring things: for instance, plugging big numbers directly can risk round-off. You might get a tiny deflection difference among options, so keep precision through calculation or use symbolic manipulation for clarity. Another note: **units in mixed-unit problems** – maybe w given in N/m and lengths in mm, etc. Convert w to N/mm or lengths to m to match. If the answer expects, say, mm of deflection, you can compute in SI (m) then convert at end.
For multi-part superposition, handle each load separately on your calculator to avoid confusion: e.g., compute deflection from load 1, store it; compute deflection from load 2, add them. This reduces error as opposed to writing a long combined expression.
Also, if using the handbook's formula table, make sure you identify the correct one – some tables have multiple scenarios and it's easy to pick the wrong one. Cross-check by verifying boundary conditions.

Explanation: Beam deflection is essentially how far a beam *bends* under load. It answers questions like, "If I put this much load on that beam, will it sag an inch or a foot?" It's critical for serviceability (cracking drywall, feeling floor bounciness) and alignment of parts in machines. For exam purposes, you're applying the elasticity theory: EI is the beam's resistance to bending, and the load and span create bending moments that overcome this resistance to produce curvature and deflection. The integration method or provided formulas let you quantify that.

A common exam scenario might be: *"Given a simply supported beam of length L with a centered load P, find the deflection at mid-span."* You'd recall or derive $\delta = PL^3/(48EI)$. Another: *"A cantilever of length L has a uniform load w, what is the deflection at the free end?"* Answer: $wL^4/(8EI)$. Sometimes, the question is framed as *which beam deflects more?* – for instance, comparing two beams with different E, I, L. Then you conceptually use the scaling of $\delta \sim L^3/(EI)$ (for a point load) or $\sim L^4/(EI)$ (for uniform load) to judge. The longest, most flexible one will deflect more. Or an exam question might give multiple choice like "Increasing which of the following will reduce deflection: A) Length, B) Elastic modulus, C) moment of inertia, D) distributed load" – you'd pick B and C (increase E or I reduces deflection, whereas increasing L or load increases deflection). They might even ask something qualitative like "If the load on a beam is doubled, the deflection will increase by factor…?" – linear if it's a point load (because P is directly proportional) or also double, but if phrased like "if all dimensions same but span doubled, deflection increases by factor 8 (for point load) or 16 (for UDL)" due to the L^3 or L^4 relationship.

Beam deflection problems test whether you understand how geometry and material affect flexibility. Engineers must ensure beams are not only strong enough (stress OK) but also not too floppy (deflection OK). For instance, a steel bar and an aluminum bar of the same size under the same load – aluminum (lower E) will sag more, maybe too much, even if stresses are fine. The FE exam integrates these concepts in questions, so having a handle on deflection calculation is key.

Analysis: Let's parse the bending deflection considerations in a step-by-step way: - Start by finding the **bending moment expression** $M(x)$ for the beam (via a shear/moment diagram or equilibrium). This is crucial because it's what you integrate. For simple cases, $M(x)$ might be a simple shape: linear for a uniform load, constant for a pure moment, piecewise linear for a point load. For example, for a simply supported beam with a mid load, $M(x) = Px$ for $0 \le x \le L/2$ (increases linearly to mid) and $M(x) = P(L - x)$ for $L/2 \le x \le L$ (decreases linearly to zero at right support).

- **Integrate $M(x)$ twice**: The first integration gives the slope (plus an integration constant C_1), the second gives deflection (plus another constant C_2). Write the general form with C_1, C_2. - **Apply boundary conditions**: This is the make-or-break step. Plug in the

known conditions. For simply supported at $x = 0$: $y(0) = 0$. At $x = L$: $y(L) = 0$. Those give two equations to solve for C_1, C_2. For a cantilever: at fixed end $x = 0$, $y(0) = 0$ and $y'^{(0)} = 0$. For a fixed-pinned (one end fixed, one simply supported) or overhang, you set accordingly. If you have symmetry, like a load at mid-span, you know slope zero at mid (peak deflection point). Use that to simplify or find constants. - Solve for C_1, C_2 and thus have $y(x)$. Then find the quantity of interest (often the maximum deflection). Usually it's at a point of zero slope or at a free end or at mid-span in symmetric cases. You may need to evaluate $y(x)$ at that point.

- **Units check & magnitude sense**: After computing δ, see if it's in reasonable range. A quick way: calculate the deflection in terms of ratio to span (like δ/L). If E and I are such that the ratio is like 1/100 or 1/1000, that's typical. If you got 0.5 (like 50% of the span!), something's off (the beam likely would have yielded long before sagging half its length). –

Look at each parameter's effect:

- If **load** P **or** w **increases**, deflection increases proportionally (because M scales with load, and deflection integrals scale likewise). Doubling load doubles deflection.

- If **span** L **increases**, deflection increases dramatically (to the third or fourth power, depending on load type). So a small increase in span can cause a *big* increase in deflection. This is why long spans are challenging to keep stiff without deep beams or trusses. If an exam question compares two spans, remember these powers.

- If E **increases** (material stiffer, e.g., swapping wood for steel), deflection decreases linearly with $1/E$. For instance, an aluminum beam ($E \approx 70$ GPa) would deflect ~3 times more than a steel beam ($E \approx 210$ GPa) of the same shape under the same load.

- If I **increases** (thicker cross-section or orientation change), deflection drops linearly with $1/I$. Actually this is the most engineering-usable: if your deflection is too high, increasing moment of inertia (e.g., choosing a taller I-beam) is the usual fix. Doubling I (say by using a deeper section) halves the deflection.

- If a beam is **fixed at ends** rather than simply supported, it's much stiffer (roughly 4x stiffer in deflection for mid-span for symmetric loads, because the rotations at the ends are restrained, distributing moment differently). So fixity is a powerful way to reduce deflection, but it introduces moments at supports.

- **Check boundary satisfaction**: After deriving, if possible, mentally verify: does $y = 0$ at supports? Does slope match expectations (e.g., for simply supported, your C_1 should yield $y'^{(0)}$ which equals initial slope and should point the deflection shape into the beam). These can catch algebra mistakes.

- **Example sanity check**: Imagine a 10 m span steel beam (say an I-beam) with a uniform load causing bending moment roughly $M \sim wL^2/8$. If w is, say, 10 kN/m (like heavy load), $M_{max} \approx 10100/8 = 125$ *kN·m. If the beam is something like an W310x31 (just guessing,* $I \sim 2.1 \times 10^{-5}$ *m⁴, E=210 GPa), then* $\delta \approx 5wL^4/(384EI) = \frac{51010^4}{384210e92.1e-5}$. *Crunch: numerator* $51010000 = 500000$, *denominator* $384210e92.1e - 5 \approx 3844.41e6 = 1.693e9$. Ratio $\approx 2.95e - 4$ m = 0.295 mm. That's a small deflection (L/~34000). If something yields a deflection of 100 mm on that beam, that'd be enormous and clearly wrong unless my assumptions were drastically different. So knowing typical deflections are often in the mm range for steel beams under usual loads, any answer in tens of cm would raise an eyebrow unless it's a very flimsy scenario.

- **Pitfall to avoid:** sometimes, exam problems might incorporate multi-step thinking. For instance, they might first ask you to compute I of a built-up section, then use it to compute deflection under a load. Ensure you don't use the wrong axis for I (e.g., bending about weak vs strong axis). Always use the I corresponding to the plane of bending. If a beam's strong axis I is huge, deflection will be small; if loaded about weak axis (sideways bending), I is much smaller, deflection big. The exam might indirectly test that concept by seeing if you know which I to use given a load direction.

- **In summary:** Bending deflection is conceptually straightforward – if you apply a load, the beam curves. The math via $EIy'' = M$ is systematic. In exam conditions, lean on known formulas or symmetry to save time. Use integration if it's a novel distribution. Always apply BCs carefully and double-check results physically. With practice, you also develop a sense: "This beam will deflect a few mm" or "This one will barely move" based on relative stiffness, which can help eliminate implausible answer choices.

K08.T09.S04 – Deflection due to Thermal Loads (Thermal Expansion in Structures)

Principle introduction: Temperature changes can cause structures to **expand or contract**, producing deformations and potentially significant internal forces if the expansion is restrained. In the context of deformations:

- **Thermal expansion (free)**: If a member of length L experiences a uniform temperature increase ΔT, and it is **free to expand**, it will elongate by $\delta_t = \alpha \Delta T\, L$. Here α is the coefficient of linear thermal expansion (how much a unit length expands per degree of temperature increase). This deformation is analogous to the mechanical elongation we discussed, but caused purely by thermal motion of atoms.

- **Constrained expansion**: If the member is **not free** to expand (say it's anchored at both ends), it *wants* to elongate by $\alpha \Delta T L$ but cannot – this will induce thermal stress. Essentially, the supports exert forces to prevent the expansion, resulting in compressive stress in the member. The thermal deformation is converted to force via the stiffness: the member experiences the same effect as if someone compressed it by the amount $\alpha \Delta T L$. In fact, the induced stress (if fully fixed ends) can be calculated by $\sigma_{\text{thermal}} = E\alpha\Delta T$ (we derive this below). If the supports weren't infinitely rigid (maybe one end on a spring or a flexible structure), there would be a partial expansion and partial stress – but typical exam scenarios consider the extreme cases of free expansion or fully restrained expansion.

- **Thermal strain and stress**: The thermal *free* strain is $\epsilon_{\text{th}} = \alpha\Delta T$. It's positive for expansion (heating) and negative for contraction (cooling). If expansion is fully prevented, the material instead experiences a mechanical strain of equal magnitude but opposite sign to keep total strain zero (since it can't change length). By Hooke's law, that mechanical strain $\epsilon_{\text{mech}} = -\alpha\Delta T$ corresponds to a stress $\sigma = E(-\alpha\Delta T) = -E\alpha\Delta T$. The negative sign indicates compressive stress for positive ΔT. So the magnitude of stress is $E\alpha\Delta T$. This can be huge for big temperature changes – often greater than yield stress if ΔT is large and no expansion joint is provided.

- **Constrained thermal deflection**: Sometimes structures relieve thermal stress by **deflecting** instead. For example, a long pipe bent in a loop will expand by flexing outwards a bit. A bimetallic strip

(two materials with different α bonded together) will **curve** when temperature changes – one side expands more, causing bending instead of pure extension. The exam might not get into bimetal calculations, but qualitatively: differences in expansion can cause bending deformations in composite structures.

- **Thermal expansion joints**: In building or bridge design, you often see expansion joints – gaps or sliding supports that allow a beam to expand without developing large stress. If an exam question describes a scenario with a gap or a stop, you may have to consider whether the expansion will fully occur or be partially restrained. For instance, "a rod is anchored at one end and has a gap of 2 mm at the other end to a rigid wall; if heated, how much will it expand and will it touch the wall?" If the free expansion $\alpha \Delta T L$ is less than 2 mm, it will expand freely that much and not yet touch the wall (no stress yet). If it tries to expand more than 2 mm, it will expand 2 mm to close the gap, then any further expansion beyond that is restrained and induces stress.

- **Typical values of α:** Metals: $\alpha \sim 10^{-5}$ (per °C). E.g., steel ~$12 \times 10^{-6}/°C$, aluminum ~$23 \times 10^{-6}/°C$ (almost double steel's). Concrete ~ $10 \times 10^{-6}/°C$. Plastics and composites vary widely. If temperature changes by tens of degrees, strains of order 10^{-4} or 10^{-3} can accumulate – significant if fully restrained. For a 10 m concrete slab, a 20°C change yields $\delta_t = 10e - 62010 = 0.002m = 2mm$ free expansion, which must be accommodated (via joints or gaps). - In the FE exam context, you might get a question: "A steel beam is locked between two columns with no gap. If the temperature rises by X°C, what stress develops in the beam?" or "What force is exerted on the supports?" (force can be found by σA if needed). Or conversely: "If one support is flexible, how far does it move and what stress results?" – maybe a bit more advanced, but we can handle conceptually by recognizing partial restraint is like a spring problem.

- Another scenario: **thermal curvature** – if only one side of a structure is heated (non-uniform temperature), it can bend (e.g., a bi-metallic strip or a deep beam with temperature gradient). This effectively causes a deflection as one side expands relative to the other. But detailed calc of that is beyond typical FE (unless formula given). We mostly stick to uniform ΔT cases.

Exam Handbook Search Cues (Not affiliated with or endorsed by NCEES): *thermal stress, thermal expansion, coefficient of expansion, constrained thermal deformation* (these help find the α definitions or formulas in the reference; e.g. "Thermal Deformations" entry or "Stress and strain caused by temperature changes").

Definition/Note Passport – Coefficient of Thermal Expansion & Thermal Strain

Plain-language definition: The **coefficient of linear thermal expansion (α)** is a material property that tells you how much a material expands per degree of temperature increase. For example, if $\alpha = 12 \times 10^{-6}/°\text{C}$ for steel, that means a 1 meter steel bar will elongate by 12×10^{-6} meters (i.e. 12 μm) for every 1°C rise in temperature (assuming it's free to expand).

The associated **thermal strain** is simply $\epsilon_{\text{thermal}} = \alpha \Delta T$. This is the change in length per original length due to a temperature change ΔT, if unconstrained. It's positive for expansion (warming) and negative for contraction (cooling). Often, engineers just remember "$\alpha \Delta T$" as the strain from a temperature change.

Where it matters (exam impact): Thermal expansion shows up in problems where structures experience temperature changes. On the FE Mechanical exam, you might be asked to calculate: the free expansion of a member (e.g., "how much longer does a 3 m aluminum rod get with a 50°C rise?"), the force or stress induced if that expansion is restrained ("if that rod were welded between rigid supports and couldn't expand, what stress builds up?"), or whether a gap will close due to thermal growth. It can also appear in fit problems (like shrink fits: heating a ring to fit over a shaft) or composite materials with different expansions causing internal stress. Recognizing the role of α and ΔT is the key – look for keywords like "thermal", "temperature increase", "expansion", "prevents expansion" etc.

Pitfall or confusion point: A big source of confusion is **unit consistency for temperature**. α is often given per °C (or per K, since a change of 1 K = 1 °C). If a temperature change is given in Fahrenheit, you either need α in per °F or convert the temperature change to Celsius-equivalent. Specifically, $\alpha_{(\text{per °F})} = \alpha_{(\text{per °C})}/1.8$ because 1°C change = 1.8°F change. Also, note that ΔT in Kelvin is the same magnitude as in Celsius (100 K drop is 100°C drop) so mixing those is fine for difference, but be careful not to use a temperature *reading* in equations – always the change. Another point: sometimes people think if both ends are fixed and temperature rises, the rod expands and "bends" – but if truly both ends are fixed and aligned, the rod will not bend (it has nowhere to go laterally unless it buckles under huge stress). Instead, it just builds stress. Bending would require some asymmetry or slack. So, if completely restrained axially, no deflection occurs, only stress. If one side can move a bit, you get partial deflection and partial stress.

Micro-check: **True/False:** If a steel bar is heated uniformly and allowed to expand freely, it will experience thermal stress. **Answer:** False. (No stress if it's free to expand; stress only develops if expansion is restrained. Free expansion just changes length with no internal force.)

Equation Passport – Thermal Stress in a Restrained Member
Name and purpose: Thermal stress (fully restrained) – calculates the internal stress induced in a member when a temperature change occurs and the member is prevented from changing length. It answers "how much stress builds up due to thermal expansion/contraction if the member cannot move?". This is critical for understanding expansion joints: if you don't allow movement, you get potentially large stresses.

Equation:

$$\sigma_{\text{thermal}} = E\,\alpha\,\Delta T$$

(This is the magnitude of stress induced. The sign will be tensile if ΔT is negative (cooling causing contraction that is prevented, thus the bar is in tension), or compressive if ΔT is positive (heating causing expansion that is prevented, bar in compression).)

Variables and units:

- σ_{thermal} – **thermal stress** developed in the material, in **Pascals (Pa)** or **psi**. This is basically an internal normal stress (like what you'd get from a mechanical load, but here from temperature).

- E – **Young's modulus**, in **Pa** or **psi**. Use the appropriate value for the material (e.g., steel ~ 200 GPa, aluminum ~ 70 GPa, concrete ~ 25 GPa in compression, etc.).

- α – **coefficient of linear thermal expansion**, in **(strain per degree)** e.g. $1/°\text{C}$ or $1/°\text{F}$. Typical values: steel $\approx 12 \times 10^{-6}/°\text{C}$, aluminum $\approx 23 \times 10^{-6}/°\text{C}$, etc. Make sure α and ΔT use the same temperature unit scale.

- ΔT – **temperature change** experienced by the member, in **degrees Celsius (°C)** or **Kelvin (K)** or **degrees Fahrenheit (°F)**. It's the difference between final and initial temperature ($T_{final} - T_{initial}$). Use a positive ΔT for heating (temperature rise) and negative for cooling. As noted, $1\ K = 1$ °C for changes, whereas degrees Fahrenheit need conversion if α is per °C.

Assumptions and scope:

- **Uniform temperature change:** We assume the entire member experiences the same ΔT. So it expands uniformly. No temperature gradient along the member (gradients cause differential expansion and bending or more complex stresses).

- **Complete restraint (no deformation):** This formula assumes the member's ends are fixed such that it cannot expand or contract at all. That means the thermal strain that would have occurred, $\alpha\Delta T$, is fully "restrained" and instead appears as elastic strain in the opposite sense (hence stress). If the member can move even a little, the stress will be less than $E\alpha\Delta T$ because some strain is relieved by actual deformation. In other words, this is the *maximum* possible thermal stress for a given ΔT, occurring under total restraint.

- **Linear elastic response:** The stress computed is within elastic range of the material. If $E\alpha\Delta T$ exceeds the yield strength, in reality the material would yield (plastically deform) and the stress would be capped around yield strength (while the rest of expansion goes into permanent set or buckling). The exam usually doesn't go that far – typically the numbers are within elastic range or they might conceptually ask what happens if it exceeds yield (answer: the member yields or buckles instead of taking more stress).

- **No external load concurrent:** We consider purely thermal stress. If mechanical loads are also present, the total stress would superpose (if within elastic range) – e.g., a hot tightened bolt sees stress from preload + thermal expansion if constrained. But exam questions usually isolate the effect or ask for total by adding contributions.

Limit tests (sanity checks): If $\Delta T = 0$ (no temperature change), then $\sigma_{\text{thermal}} = 0$ – correct, no thermal stress without temperature change. If the member is made of a material with almost zero α (like Invar, a low expansion alloy), then σ will be negligible even with big ΔT (that's why such materials are used for precision instruments). If α is typical and ΔT is large, σ can be huge: for steel, $\alpha \approx 12e-6$; a $\Delta T = 100$°C gives $\sigma = 200e9 * 12e-6 * 100 \approx 240e6$ Pa = 240 MPa, which is on the order of yield strength for some steels – meaning a 100°C change could nearly yield the steel if fully restrained! That makes sense – structures need expansion gaps or else thermal loads can indeed cause yielding or damage (think of rail tracks on a hot day). If E is smaller (say rubber with low E), the same ΔT yields much smaller stress – that's why materials with low stiffness can handle expansion internally (they'll deform more, but not generate as high stress). Also check units: if α is per °F, and ΔT is in °F, it might be easier to convert both to SI (°C) for calculation. Example: $\alpha_{steel} \approx 6.6e-6/$°F, $\Delta T = 180$°F (which is 100°C), $E = 29000$ ksi. Then $\sigma = 29000\text{ksi} * 6.6e-6 * 180 = 34.45$ ksi. Direct computing in mixed units can work if consistent (here it did because I used per °F and °F). It's safer to convert: 100°C, $E = 200$ GPa, same result 240 MPa = 34.8 ksi. It matches. If you mistakenly used α per °C with ΔT in °F without converting, that would be wrong (factor of 1.8 error).

Use vs. sibling equations: Use $\sigma = E\alpha\Delta T$ when you're dealing with **thermal stress under complete restraint**. If the problem is asking for **actual expansion (deflection)** when something is not fully restrained, you'd use the expansion formula $\delta = \alpha\Delta TL$ (sibling equation in axial deformation context). If a structure is only partially restrained (e.g., a rod between springs or with a gap), you might have to do a superposition or compatibility analysis: allow it to expand freely then "remove" some expansion by applying an opposite force until it fits the restraint condition. That effectively means solving $PL/(AE) = \alpha\Delta TL - \delta_{\text{allowed}}$ or similar, where P is the force induced. It can be simpler: if there's a gap, first δ closes gap, then remaining δ becomes constrained. So treat in steps. The given formula is not directly applicable to partial restraint except as an end-member. Another related use: thermal strain in one material vs another – e.g. a bimetal strip, the difference in α causes bending. You won't directly use $\sigma = E\alpha\Delta T$ there, but you might use $\Delta\alpha\Delta T$ to find curvature. That's beyond our scope here, but just noting context. Also note: if asked for **thermal force** in a restrained member (like "how much force does the expanding rod exert on the wall?"), you can get that by $F = \sigma A = E\alpha\Delta T * A$. Essentially treat it like the rod is a stiff spring with $k = AE/L$; if it were free it'd expand $\alpha\Delta TL$, but since it's fixed it compresses back that amount, generating $F = k\delta = (AE/L)(\alpha\Delta TL) = AE\alpha\Delta T$ – same result as σA. So either way, use this σ to get F.

Common exam traps:

- **Unit conversion for temperature:** As mentioned, one of the biggest pitfalls is mixing up Celsius and Fahrenheit. For example, a problem might state "temperature rises 40°F" and give α in $1/$°C. You must convert 40°F change to $40/1.8 = 22.2$°C change *or* convert α to per °F. Forgetting this will give an answer off by 80%. Keep an eye on units in thermal problems, especially since the U.S. still often uses °F.

- **Sign of stress:** It's easy to lose track of sign. If something is heated ($\Delta T > 0$) and it's restrained, it goes into compression (tries to get longer, but can't, so it's squished by the supports). That is a compressive stress. Many times exam answers might only expect magnitude, but if it asks "tensile or compressive?", know the sign. Conversely, cooling ($\Delta T < 0$) makes a restrained member try to contract – it will be in tension (pulled by the constraints). A common confusion is thinking "heat = tension" because heat expands and might "pull" – but actually if ends are fixed, heating pushes on ends (compression). An intuitive check: rails in the sun buckle in compression, not pull apart.

- **Assuming stress without restraint:** Another trap is calculating $E\alpha\Delta T$ in a scenario where the member actually *can* move. If a problem says "a steel rod attached to one end but free on the other is heated – what's the stress?", the answer is zero (essentially free expansion, no stress). If you erroneously applied $\sigma = E\alpha\Delta T$, you'd get a number, but that would be incorrect because one end was free. So always assess: is it fully restrained, partially, or free? Only fully fixed both ends yields that full stress. Partial means lower stress (proportional to degree of restraint).

- **Forgetting to include mechanical strain if combined loading:** If a rod has both a load and a temperature change, total strain = mechanical strain + thermal strain. If it's fixed and loaded, etc., you might need to add stresses. For example, a bolt tightened to some stress then heated will see additional stress from thermal expansion being restrained by whatever it's clamping. They might ask conceptually: "if a bolt is preloaded to X and temperature rises, does tension increase or decrease?" (It can decrease if the parts it clamps expand more than the bolt, or increase if bolt expands but is constrained by cooler parts – this can get tricky, but usually they avoid such combined complexity. If they do, you'd consider expansion of bolt vs expansion of clamped parts relative – a

differential expansion problem.) Typically, treat each effect and superimpose linearly if elastic.

- **Buckling vs stress:** If the computed $\sigma = E\alpha\Delta T$ exceeds the critical buckling stress for a long slender column, the structure won't actually reach that stress – it'll buckle (deflect laterally) at a lower stress. The exam might ask something like: "A long pipe fixed at both ends is heated significantly. What failure mode is of concern?" The answer: **thermal buckling** (because compression induced can cause it to buckle if slender). So realize, if something is slender and fully fixed, heating it is like applying compressive force, which can cause buckling rather than just stress. That's a concept: compressive thermal stress can drive buckling. For short thick members, yielding (crushing) might happen if stress > yield. So absolute restraint + big ΔT could either yield or buckle structures – design provides expansion joints to avoid either.

- **Nonuniform expansion (bimetal strip confusion):** If the exam shows something like two materials with different α bonded, don't mistakenly use $E\alpha\Delta T$ directly for stress – that scenario causes bending (one side in tension, other in compression). The proper analysis is more complex (involves curvature to satisfy compatibility). They probably would only ask a conceptual question about which way it bends or which material experiences tension on heating (the material with higher α expands more, causing it to be on the convex side when strip bends, putting the higher α material in compression on the concave side because it tries to expand more but is held back by the other – easier said: the strip bends towards the side of the material with the lower α, so the high α material is on outside of bend, in tension? Actually need to recall: if one tries to expand more, it will end up longer, so to accommodate that while bonded, the composite must curve with the higher α material on outer (longer) side, meaning the higher α layer is in tension? Wait, in a bimetal, the strip bends towards the material with the lower expansion (because the high expansion side elongates more and becomes longer). This puts the high α material on the outside curve (tension) and low α on inside (compression). That's a nuance. They might not go there, but just in case, think it through carefully if needed.)

- **Thermal strain vs mechanical strain sign**: total strain = free thermal strain + mechanical strain (from stress). Under full restraint, total strain is zero, so mechanical strain = - thermal strain = -αΔT. Students sometimes add instead of subtracting. If you do $\sigma/E = \epsilon_{\text{total}} = \epsilon_{\text{mech}} + \epsilon_{\text{thermal}}$, under full restraint $\epsilon_{\text{total}} = 0$, so $\sigma/E + \alpha\Delta T = 0 \Longrightarrow \sigma = -E\alpha\Delta T$. It's important to get that sign right to indicate compression or tension correctly.

- **Forgetting expansion in multiple dimensions:** For structures (like area expansion or volume expansion), α we use is linear. Sometimes they mention $\alpha_{area} \approx 2\alpha_{linear}$, $\alpha_{vol} \approx 3\alpha_{linear}$ if needed. For FE Mechanical, usually stick to linear expansion in one dimension (like length of a rod, or perhaps diameter of a hole expanding linearly – yes holes expand too as if it's the material). If they do mention a hole expansion: treat the diameter of hole as if it's a length – it expands by αΔT times original diameter.

Variations, related forms, typical values:

- **Partial Restraint (springs or gaps):** If the structure isn't completely rigid on both ends, you have a partial restraint scenario. A classic problem: a rod between two walls, one wall is fixed, the other attached to a spring (spring constant k). Temperature rises, rod tries to expand, compresses the spring. Equilibrium at a point where rod expansion δ reduces the stress such that $P = k\delta$ reaction. You can solve by compatibility: the rod expands by some δ (compressing spring same δ), so free expansion would've been $\alpha\Delta TL$, the difference $(\alpha\Delta TL - \delta)$ is how much expansion *didn't* happen, which is the mechanical compression of rod. So $\epsilon_{\text{mech}} = (\delta - \alpha\Delta TL)/L$? Actually, easier: force in rod $F = k\delta$. Also $F = \sigma A = EA(\text{mechanical strain})$. Mechanical strain = actual $\Delta L/L$ minus thermal strain = $\frac{\delta - \alpha\Delta TL}{L}$, but since one end is actually moving by δ, maybe better: at equilibrium, the rod is longer by δ (spring allowed δ), whereas free would be αΔT L, so rod is effectively compressed by (αΔT L - δ) from its free length. That compression causes stress. So $\sigma = E * \frac{\alpha\Delta TL - \delta}{L}$. And $\sigma A = k\delta$. Combine: $EA(\alpha\Delta TL - \delta)/L = k\delta$. Solve for δ. This yields $\delta = \frac{EA}{EA + kL}(\alpha\Delta TL)$ – meaning a fraction of free expansion occurs. If k→∞ (wall rigid), δ→0 (no expansion, as expected). If k→0 (wall free), δ→αΔT L (full expansion). This formula is beyond what you might have to derive in exam conditions, but conceptually: the stiffer the restraint (large k or small give), the closer you get to full restraint stress and near-zero expansion. The softer the restraint, the more expansion happens and the less stress.

- **Thermal deflection in composite structures:** E.g., a bimetallic strip (two materials with α1, α2, and different E maybe). On heating, it will curl. The curvature κ can be derived (involves mismatch strain and the composite flexural rigidity). It might be beyond FE; just qualitatively, know it bends toward the lower expansion side. Another example: a steel reinforced concrete beam – if temperature changes, steel and concrete have slightly different α but are bonded, causing internal stress at interface (this could be tested conceptually, but since their α are actually similar, maybe not significant).

- **Expansion allowances:** Engineers put expansion joints in bridges (gap that opens/closes with temperature), rollers on one end of long beams (allow one end to slide), etc. A typical expansion joint might allow a few inches movement for long structures. If asked how big a gap should be for given ΔT to avoid crushing, you'd compute ΔL = α L ΔT and ensure initial gap ≥ that.

- **Creep and relaxation:** Over long term, some materials under sustained thermal stress might creep or relax, reducing stress. Not likely on FE, but a note: e.g., glass, concrete, metals at high temp – if continuously restrained, they might relieve some stress via creep.

- **Thermal strain in context:** Often combined with stress due to other loads in formulas like "total strain = (σ/E) - αΔT" (negative because thermal expansion is considered "free expansion" subtracts from mechanical strain if restrained). In plane stress or plane strain, thermal expansion appears in multi-axial Hooke's law as $\epsilon_x = (1/E)[\sigma_x - \nu\sigma_y] + \alpha\Delta T$ for plane stress (the αΔT term added to free strains). This tells in multidimensional state, temperature just adds to each normal strain. The FE exam might not require plugging into those equations explicitly, but for completeness: in 3D, $\epsilon_x = \frac{1}{E}[\sigma_x - \nu(\sigma_y + \sigma_z)] + \alpha\Delta T$ and similarly for others, or in matrix form $\Delta\ell/\ell = \alpha\Delta T$ gets added.

- **Typical values recap:** - Steel: $\alpha \approx 12 \times 10^{-6}/°C$. So a 100°C change -> 0.12% strain. E ~ 200 GPa, so σ ~ 240 MPa if fully restrained. - Aluminum: $\alpha \approx 23 \times 10^{-6}/°C$, E ~ 70 GPa, so 100°C -> 0.23% strain, σ ~ 161 MPa (lower E, but higher α, somewhat comparable stress). - Concrete: $\alpha \approx 10 \times 10^{-6}/°C$, E ~ 30 GPa (for rough calc), 100°C -> σ ~ 30 GPa * 1e-5 *100 = 30 MPa* (and concrete would crack well before that in tension or crush in compression likely). Usually structures wouldn't see 100°C swings (maybe 50°C seasonal). - Polymers: can have very high α (10x metal) but low E, so stress might not be too high. - These show metal structures must account for thermal expansion or else high

stresses occur. The FE might ask a conceptual Q: "Given equal lengths steel and aluminum rails, both anchored at ends and same ΔT, which develops more stress?" Calculation: $\sigma = E\alpha\Delta T$. For steel ~240 MPa, aluminum ~160 MPa (with numbers above), so steel actually gets higher stress because its much higher E outweighs aluminum's higher α. So the steel is at more risk of yielding under same ΔT fully restrained. This is a subtle interplay: aluminum expands more but is more compliant; steel expands less but is very stiff, so the product Eα matters. - Buckling risk: If a slender column is fixed-fixed and heated, it will act like an axial load $P = AE\alpha\Delta T$ applied. If that P exceeds P_{cr} (Euler buckling load), the column will bow out (thermal buckling). So sometimes design must ensure $E\alpha\Delta T < \frac{\pi^2 EI}{(KL)^2}$ for that column (where K depends on end conditions, here K=0.5 for fixed-fixed). Cancel E: requirement becomes $\alpha\Delta T < \frac{\pi^2 I}{(KL)^2 A} = \frac{\pi^2}{(KL/r)^2}$ times something – essentially a slenderness relation. Possibly too advanced for FE except conceptually. - Thermal expansion of area/volume: If needed, area expansion coefficient ~ 2α, volume ~ 3α. Example: a steel plate 1 m x 1 m, if ΔT=50°C, area expansion ~ $2\alpha\Delta T = 212e - 650 = 0.0012$ (0.12% area increase), so new area ~1.0012 m². Usually not needed explicitly unless a weird question on fit of a plate in a frame when heated, etc. - Bridging to thermal strain in heat transfer context:* Sometimes a thermal stress question may tie into heat transfer: first find temperature change from some heat source, then compute expansion. But probably separate topics in exam.

Special notes (calculator and approach): These calculations are usually straightforward multiply/divide. Just be cautious with scientific notation and unit conversions (I keep repeating because it is the most common error). On your calculator, $\sigma = E\alpha\Delta T$: if $E = 210e9, \alpha = 12e - 6, \Delta T = 30$, you can do $210e9 * 12e - 6$ in one go (which gives $2.52e6$), then times 30 = $7.56e7$ Pa (which is 75.6 MPa). Or break it: $E\alpha = 2.52e3$ (in MPa, actually, since 210 GPa * 12e-6 = 2.52e6 Pa, which is 2.52 MPa per °C), then times ΔT. Realize many material charts list $E\alpha$ as a combined term (like "constraint stress per °C"). But you won't likely have that on exam, just compute directly. For free expansion: $\delta = \alpha\Delta TL$, similarly easy: just multiply those, again watch units (L in m, α in 1/°C, ΔT in °C yields δ in m; if L in mm, α in 1/°C, ΔT in °C, δ in mm – that's fine as long as you stay consistent, because you effectively multiplied mm by a dimensionless and by °C which cancel). If dealing with partial restraint (less likely as a direct calc), set up equilibrium and compatibility carefully. Possibly easier to do using the concept of *equivalent force*: A fully restrained expansion exerts a force $F = EA\alpha\Delta T$. If partially restrained by a spring or another member, one can write equilibrium of forces and compatibility of deflections. That's an advanced use – good news, such a scenario often simplifies to treat series springs: the rod (spring constant $k_{rod} = AE/L$) in series with another spring k_{spring}, and the thermal expansion is like a "free expansion" input. The fraction of expansion that turns into compression of rod = $k_{spring}/(k_{rod} + k_{spring})$ times total expansion, something like that. Anyway, for straightforward Qs, just apply formula or reason qualitatively if it's asking increase/decrease.

Explanation: Thermal deflections are conceptually simple: when materials heat up, they expand; when they cool, they shrink. The engineering complication is when that expansion or contraction is restrained by supports or other parts – then something's gotta give, either the material deforms elsewhere (bends, buckles) or stress builds up. On the FE exam, you might be asked directly "how much does this part expand?" or "what stress is caused by a temperature change?". Usually, those are direct formula applications. Another angle: they might embed it in a bigger problem, like a statics problem where a rod in a truss is slightly too short or long due to temperature change, affecting forces.

One typical example: *"A steel rod is tightly pinned between two immovable walls at 20°C with no initial stress. If the temperature rises to 50°C, what is the resulting stress in the rod?"* Here you identify fully restrained (walls immovable), compute $\Delta T = 30°C$, and plug into $\sigma = E\alpha\Delta T$. Another: *"An aluminum beam is simply supported (so it can expand freely along its length). The temperature goes up 40°C. How much does its length increase?"* There's no restraint to stop expansion along the span (simply supports only hold it vertically, not axially), so it will get longer by $\delta = \alpha\Delta TL$ and it will actually just push a little over the supports (perhaps causing small axial force if friction, but ideally roller support allows free expansion). So the answer would be $\alpha L\Delta T$. They could also ask: *"If that beam were welded at both ends (fixed in place), how much stress or what force develops?"* Then use $\sigma = E\alpha\Delta T$ (and force $F = \sigma A$). Or a gap problem: *"A bronze rod is attached to a wall on one end and has a 2 mm gap to another wall on the other end. It's 3 m long at 20°C. How hot must it get to just touch the other wall?"* There, you set $\alpha\Delta TL = 2$ mm and solve for ΔT. That finds the temperature where expansion equals gap. If it asks stress after that once it touches, you'd then do further if it continued to heat beyond that, now it's restrained, use σ formula for any further ΔT beyond closure.

Thermal loads are often *secondary loads*, meaning they come from imposed deformation rather than direct force. The exam might treat them as such: if an element is free to expand, no force; if not, it's like a force was applied. So a savvy approach is: treat thermal expansion like an applied "equivalent force" or "strain" in structures. For instance, in indeterminate analysis, a common technique is: find what external load would cause the same deformation as thermal expansion and solve that. But likely FE won't dive deep into that – they'll stick to fundamentals: $\delta = \alpha\Delta TL$ and $\sigma = E\alpha\Delta T$.

The importance of understanding this is high: many mechanical failures occur due to ignoring thermal expansion (like buckled rails, cracked pipes, stuck valves). For exam quick answers: expansion joints good, full restraint causes big forces. Another concept: thermal stress *does not depend on length*. Notice $\sigma = E\alpha\Delta T$ had no L in it. A long and a short restrained rod have the same stress for same ΔT (provided they're fully constrained). They'll have different *force* ($F = \sigma A$ same if cross-section same, well actually same if area same too; if area same, yes same force too, which is interesting – independent of L, because a longer rod, though it wants to expand more absolute amount, also is more flexible (lower stiffness AE/L) so it ends up same stress). That's an interesting point: in $\sigma = E\alpha\Delta T$, L canceled out – meaning no matter the length, the stress is the same (assuming uniform T change). For free expansion, δ does scale with L, a longer rod expands more in absolute terms but stress free. So if a question tries to trick: "which experiences more thermal stress: a 1 m rod or 2 m rod with same ΔT fully fixed?" Answer: both the same stress (the longer rod would push with same pressure but just move walls more if could).

Analysis: Let's break a typical thermal deformation scenario in steps: - **Identify constraint conditions:** Is the member free, partially, or fully restrained? This dictates if we compute a deformation or a stress. - If free: no stress, just expansion $\delta = \alpha\Delta TL$. - If full fixed: no expansion, just stress $\sigma = E\alpha\Delta T$ (and associated force $F = EA\alpha\Delta T$ if needed). - If partial: a combination – often requires a bit of extra work (superposition or ratio as earlier).

- **Apply linear expansion formula for free expansion:** e.g., a pipe of 100 m, ΔT=30°C, $\delta = 12e - 630100 = 0.036$ m (36 mm). That's quite a movement! If there's flexibility to allow it, fine; if not, think what happens.

- **Compute induced stress/force if restrained:** For the above, if that 100 m pipe were anchored both ends, $\sigma = 200e912e - 630 = 72e6$ Pa = 72 MPa. And $F = \sigma A$: if pipe cross-section area e.g. 0.01 m², $F = 0.0172e6 = 720e3$ *N, i.e. 720 kN pushing on anchors. That's huge (equivalent to, say, roughly 72 tons of force). So obviously, you wouldn't rigidly fix a 100 m pipe without expansion loops or joints, or it will either break something or buckle.*

- **Check yield or buckling**: If 72 MPa is below yield (for steel yield ~250 MPa), it's elastic, so no yield but still significant stress. If ΔT were bigger or length diff, could reach yield. If slender, check Euler: for a 100 m slender pipe, likely it would buckle sideways before hitting yield in pure compression. Real world, they put expansion loops (like U-shape bends) which flex to absorb expansion rather than compressing the pipe. - Signs and directions: If the exam expects a directional answer: - Heating (ΔT positive) + fixed ends → compressive stress (the member is in compression).- Cooling (ΔT negative) + fixed ends → tensile stress (member in tension, because it tries to contract but can't, so it's pulled).

- **Free expansion**: no stress, but movement direction: if heated, it expands (elongates); if cooled, shrinks (shortens). These could be asked conceptually.

- **Multi-material assembly**: If two different materials are fixed together (like bolt and sleeve or composite bar), when temperature changes, they might go into tension/compression relative to each other if their α differ. For example, a steel bolt in an aluminum block – if temperature increases, aluminum expands more than steel (higher α). If bolt and block are securely attached, the aluminum will push the bolt (putting bolt in tension, aluminum in compression possibly). This is analogous to a press fit that changes with T. The exam might skip the detailed calc (which would require equilibrium of forces and compatibility of strains between them), but conceptually: differential expansion can cause stresses even if individually they could expand freely, because they're constrained by each other. If they did require calc: say steel and aluminum same length at assembly, heated ΔT, aluminum wants to be longer by ΔL_a, steel by ΔL_s, difference $[\Delta(\Delta L) = (\alpha_{al} - \alpha_{st})\, L\, \Delta T]$. If stuck together, one will be in tension, one in compression to accommodate that difference. Usually solve by $\sigma_{steel} A_{steel} = \sigma_{al} A_{al}$ if cross-sectional areas differ and using $\sigma/E + \alpha\Delta T$ relationships with a sign difference. Possibly too detailed for FE unless multiple choice conceptual.

- **Final thought**: Many FE thermal questions are plug-and-chug or conceptual. They rarely involve solving big systems. The keys are: write down what's known (α, ΔT, E, L, maybe A), decide if you use $\delta = \alpha\Delta TL$ or $\sigma = E\alpha\Delta T$ or a combination, solve, and present answer with correct units (e.g., mm or MPa as needed). For instance, if asked in mm, ensure to convert m to mm at end. If asked in MPa, that's N/mm², which is convenient if you used SI (just convert Pa to MPa by dividing by 10^6).

In summary, thermal deformations are straightforward mathematically, but *interpreting the scenario* is the important part: is it free or restrained? That determines whether you give an answer of a deformation length or a stress/force. So always picture: can it expand? If yes, no stress (just moves). If no, big stress (no movement). If partially, something in between – usually those in-between problems will either have an obvious partial result (like a given gap closing or something you can handle stepwise) or be avoided in favor of clear-cut cases on the exam.

Topic 10 - Column Buckling

Topic Introduction: Column buckling is a failure mode where a slender **column** under compressive load suddenly bends (buckles) sideways instead of crushing. It matters on the FE Mechanical Exam because many questions involve determining the **critical load** at which a column will buckle or checking if a column is *slender* enough to require buckling analysis. Typically, exam problems give you a column's material and dimensions and ask for the **Euler buckling load** or critical stress, or they present a scenario to test if you recognize the conditions where Euler's formula applies. Mastering this topic ensures you can quickly identify the buckling regime and apply the correct formula on exam day.

K08.T10.S01 – Euler Buckling Load & Effective Length Factor

Principle Introduction – Euler's Critical Load: *When a long, slender column is compressed, it remains straight until a certain maximum load is reached; beyond this, the column* buckles *laterally.* Euler's critical load formula gives this maximum **buckling load** for ideal columns:

- Euler's formula is derived for an ideal elastic column that's initially perfectly straight and has pinned ends (free to rotate at ends). At the critical load, the column can no longer stay straight and will deflect with almost no increase in load.

- The **critical buckling load** P_{cr} increases with the column's stiffness (higher material modulus E and larger moment of inertia I make it harder to buckle) and decreases rapidly with the column's length. It is very sensitive to length: a column twice as long can carry only a quarter of the load before buckling (because of the squared length term).

- Different end support conditions effectively change the column's buckling length. A column with ends that are more constrained (fixed) behaves as if it's shorter, raising P_{cr}. A free or less-supported end behaves as if the column is longer, reducing P_{cr}. The **effective length factor** K accounts for this in Euler's formula.

- **Exam tip:** Always determine the correct end condition and corresponding K before computing P_{cr}. Using the wrong K is a common pitfall that can lead to a large error (e.g. using $K = 1$ for a fixed–fixed column underestimates the critical load by a factor of 4).

Exam Handbook Search Cues (Not affiliated with or endorsed by NCEES): *Euler buckling*, *critical load*, *effective length factor*, *column end conditions* (these are keywords you'd use to find relevant formulas and tables in the exam handbook).

Equation Passport – Euler's Critical Load Formula
Name & purpose: Euler's Critical Load – computes the maximum axial compressive load (P_{cr}) at which a long, slender column will buckle (lose stability) **elastically**. This is the threshold load to avoid for column stability.

Formula (Ideal Elastic Buckling):

$$P_{cr} = \frac{\pi^2 E I}{(K L)^2}$$

where P_{cr} is the critical buckling load (force that causes buckling).

Variables & units:

- P_{cr} – critical buckling load (Newtons, N or pounds-force, lbf).
- E – Young's modulus of the column material (Pa or psi) – a measure of material stiffness.
- I – minimum area moment of inertia of the column's cross-section (m^4 or in^4) about the axis of buckling. Use the smallest I if the column can buckle in different planes.
- L – actual unsupported length of the column (m or in).
- K – *effective length factor* (dimensionless), accounting for end support conditions.

Typical values: fixed–fixed $K = 0.5$; fixed–pinned $K \approx 0.7$; pinned–pinned $K = 1.0$; fixed–free (cantilever) $K \approx 2.0$.

Assumptions & scope:

- **Long, slender, elastic column:** Euler's formula assumes the column is slender enough that it will buckle *elastically* before yielding (material stays within elastic limit up to P_{cr}).
- **Ideal conditions:** Column is perfectly straight initially, load is applied exactly axially through the centroid (no eccentricity), and ends have the defined support condition without initial moments.
- **Pinned-end derivation:** The formula is derived for pinned–pinned ends and adjusted for other cases via K. It assumes no friction or fixity beyond what K accounts for (e.g. pinned ends provide no moment resistance).
- **Small deflection theory:** Buckling shape is assumed to have small lateral deflections prior to reaching P_{cr}. The column returns to straight if load is removed before P_{cr}. (Beyond P_{cr}, large deflections occur and Euler's linear theory no longer applies.)

Limit checks (sanity tests):

- As **length** $L \to \infty$, $P_{cr} \to 0$. (An extremely long column can carry essentially no load without buckling – a good check that the formula's trend makes sense.)
- As I **(or E) increases**, P_{cr} increases. For example, doubling the bending stiffness (EI) doubles the critical load.
- If K **is smaller**, the denominator $(KL)^2$ is smaller and P_{cr} is higher – consistent with a column with more fixity being stronger. If K is larger (like a free end), P_{cr} drops significantly.
- If $K = 1$ and we shorten the column to half its length ($L/2$), P_{cr} becomes four times larger (since $(L/2)^2 = L^2/4$ in the denominator) – highlighting the sensitive L^2 relationship.

Use vs. sibling formulas: Use **Euler's buckling** instead of a simple compressive stress check ($\sigma = P/A$) when the column is *slender* and buckling clearly governs failure rather than material yielding. For short, stocky columns where Euler's formula would predict a load above the material's yield strength, use the material's compressive yield load ($P_{yield} = A\sigma_y$) as the failure criterion instead. *(In design of intermediate columns, an empirical formula like Johnson's is used to bridge the gap, but such inelastic formulas are beyond the FE exam scope.)*

Common exam traps:

- **Forgetting to square** (KL)**:** The denominator is $(KL)^2$. A common mistake is to only square L but not K. Always apply K

before squaring – for example, if $K = 0.5$, then $(KL)^2 = (0.5L)^2 = 0.25L^2$.

- **Mixing units:** Ensure E, I, and L are in a consistent unit system. If E is given in GPa and L in mm, convert to SI units (Pa, m) before using the formula, or convert everything to USCS. The result P_{cr} will come out in the force unit corresponding to your inputs (N in SI, lbf in USCS) [^1].

- **Confusing section properties:** Remember I is the second moment of area of the cross-section, not the column's length or radius. (Sometimes problems give the radius of gyration r; recall $r = \sqrt{I/A}$. If given r, you can rewrite Euler's formula in terms of **slenderness ratio** $K\,L/r$ — see subtopic 2.)

- **Applying Euler to a short column:** If the column is not slender (low slenderness ratio), Euler's P_{cr} might be higher than the yield load. The exam may test if you recognize when Euler's formula is *not* applicable – don't blindly apply it if the problem hints the column is short or if a material yield strength is provided and is lower than the Euler load. (More on this in the next subtopic.)

Special notes (calculator usage): On your FE exam-approved calculator, use the π key for accuracy and group the denominator in parentheses. For example, enter: P_cr = (pi^2 * E * I) / ((K * L)^2). Make sure to square the entire (KL) term. Also, be mindful of scientific notation for E (e.g. 200×10^9 Pa for steel's E) and use the calculator's exponent or ENG mode to avoid entry errors.

Explanation & Analysis: Euler's critical load formula is *the* go-to tool for **predicting buckling failure** of slender columns. In an exam problem, once you identify that a column is long and slender, you immediately think of Euler's formula. The basic idea: a column behaves like a spring in bending – below a certain load it stays straight, but at P_{cr} it's on the verge of lateral instability (like a ruler that suddenly bows out when you push too hard). For safety, real designs keep the actual load well below P_{cr}.

Term-by-term insight: $P_{cr} = \frac{\pi^2 E I}{(K L)^2}$ has two parts: the numerator $\pi^2 E I$ represents the **flexural stiffness** of the column (material stiffness E times geometric stiffness I, scaled by π^2 from the math of a half-sine buckling shape), and the denominator $(K L)^2$ represents the **flexural flexibility** (a longer effective length $K L$ greatly increases flexibility, and the effect is quadratic). The larger the ratio $\frac{EI}{(K L)^2}$, the larger the critical load.

Units check: If you use SI units, E in Pa (N/m²), I in m⁴, and L in m, then P_{cr} comes out in N (since Pa·m⁴ = N·m², divided by m² gives N). In USCS, using E in psi, I in in⁴, and L in inches gives P_{cr} in lbf. Always double-check units because mixing, say, inches with feet, or MPa with Pa, will throw off the result dramatically.

Effective length factor K usage: Recognize the column's end conditions in the problem: if it says "both ends pin-supported/free to rotate," that's $K = 1$. "Both ends fixed" implies a much higher capacity ($K = 0.5$). One end fixed and the other free (like a flagpole) is *very* prone to buckling ($K = 2.0$). If unsure, remember pinned–pinned is the baseline case. More constraint (fixed ends) → smaller K → stronger column; less constraint (free end) → larger K → weaker column. On exam day, use the typical K values provided or memorize the four common cases above.

Physical understanding: Euler buckling is a *stability phenomenon*. The column might be fine carrying a load up to a point, but at P_{cr} it suddenly wants to bend with any slight disturbance. This is why perfect alignment is assumed – any tiny imperfection can trigger buckling even before P_{cr} in real life [^2]. In the exam context, assume the ideal case unless told otherwise. Note that reaching the critical load doesn't mean the column has collapsed or broken; it means it has become unstable (like balancing a pencil on its tip). Beyond that load, any extra force or imperfection leads to a runaway bending deflection.

Example scenario: Suppose a steel column (E ~ 200 GPa) of length 3 m with pinned ends and a moment of inertia $I = 1.2 \times 10^{-6}$ m⁴. Using $K = 1.0$ (pinned–pinned),

$$P_{cr} = \frac{\pi^2 (200\times10^9 \text{ Pa})(1.2\times10^{-6} \text{ m}^4)}{(1.0\times3 \text{ m})^2}$$

Numerically, $\pi^2 \approx 9.87$, so the numerator $\approx 9.87 \times 200 \times 10^9 \times 1.2 \times 10^{-6} = 9.87 \times 240 \times 10^3 \approx 2.37 \times 10^6$ N·m². Dividing by $(3\,m)^2 = 9\,m^2$ gives roughly 2.63×10^5 N (about 263 kN). This means if you try to compress this slender rod with more than ~263,000 N, it will buckle. If one end were fixed and the other pinned ($K \approx 0.7$), then $(0.7 \times 3)^2 = (2.1)^2 = 4.41$, making $P_{cr} \approx 2.37 \times 10^6 / 4.41 \approx 5.37 \times 10^5$ N (537 kN). Notice the huge increase in capacity just by making one end fixed instead of pinned.

Buckling stress: The exam might ask for **critical stress** instead of load. Critical *buckling stress* is $\sigma_{cr} = P_{cr}/A$. You can compute σ_{cr} by dividing Euler's load by the cross-sectional area A, or use an equivalent form of Euler's formula: $\sigma_{cr} = \frac{\pi^2 E}{(KL/r)^2}$, where L/r (with L multiplied by K for end conditions) is the **slenderness ratio**. This form highlights that for a given material (E fixed), as the slenderness $K\,L/r$ increases, the critical stress drops with the square of that ratio. We'll discuss the slenderness ratio and when Euler's formula breaks down in the next subtopic.

[^1]: **Unit tip:** For mixed USCS units (e.g. if L is given in feet but I in in⁴), convert L to inches (or I to ft⁴) before plugging in. The critical load in lbf requires consistent inch–pound units. As a check, if you get an absurdly large or tiny P_{cr}, revisit your unit conversions.
[^2]: **Real-world note:** Actual columns have imperfections and residual stresses, so they often buckle at loads *below* the ideal Euler prediction. Design codes include safety factors or use modified effective lengths to account for this. In exam problems, unless specifically stated, assume the ideal Euler behavior to focus on the concept.

K08.T10.S02 – Euler's Formula Assumptions & Limitations

Principle Introduction – Validity of Euler's Theory: *Euler's buckling formula works under certain ideal conditions, and it can over-predict load capacity if those conditions aren't met.* It's crucial to know when **not** to use Euler's formula. Key assumptions and their implications:

- **Straight, perfectly axial loading:** The column must be initially straight with the load applied through its centroid. *No eccentricity or initial bending* is assumed. In reality, even a slight imperfection lowers the actual buckling load, but Euler's formula ignores imperfections to give an upper-bound ideal capacity.

- **Pinned ends (or known K factor):** Euler's derivation assumes pin–pin supports (no moment resistance at the ends), then generalizes via K for other cases. If end conditions differ (e.g.

partial fixity or one end not truly free), using an improper K or an unaccounted support condition can make Euler's result inaccurate. Only use the standard K values unless the problem specifies a different effective length.

- **Elastic behavior up to buckling:** The material is assumed to remain in the elastic range at P_{cr}. This means the column is *slender enough* that it buckles before any fibers yield. If the column is too short/thick (low slenderness), it might **yield (plastic compressive failure)** before it ever buckles. Euler's formula does **not** account for yielding; it will predict an unrealistically high P_{cr} in such cases.

- **Long column (high slenderness ratio):** Euler's formula is intended for **long, slender columns**. For **intermediate-length** columns (not extremely slender but not stubby either), neither pure Euler buckling nor pure yielding alone governs – the actual failure load is lower than Euler's prediction due to some inelastic behavior. In other words, Euler's formula starts to overestimate the critical load as the column gets shorter and its slenderness ratio drops into the intermediate range.

Exam Handbook Search Cues (Not affiliated with or endorsed by NCEES): *slenderness ratio*, *buckling stress*, *column yield*, *intermediate column* (these terms help locate references to column classifications and limits in the exam handbook).

Definition Passport – Slenderness Ratio (λ)
A measure of how "slender" a column is, which dictates its buckling tendency. It is defined as the effective length of the column divided by its radius of gyration:

$$\lambda = \frac{K\,L}{r},$$

where $r = \sqrt{\frac{I}{A}}$ is the radius of gyration of the cross-section. λ is dimensionless (length/length, so units cancel out).

Where it matters (exam impact): The slenderness ratio tells us which failure mode to consider. A **high** λ means a very slender column that will fail by Euler buckling at a low stress; a **low** λ means a stout column likely to reach the material's yield stress without buckling (i.e. compressive crushing). Exam questions may hint at a column being "long" or "short" – essentially referring to λ. Recognizing this guides you to use Euler's formula or not.

Pitfall: Make sure to use the correct r (radius of gyration) for the buckling axis. If a cross-section isn't symmetric, it has different r about different axes – buckling will occur about the weaker axis (the one with smaller I and thus smaller r). Also, be cautious with units: L and r must be in the same units to compute λ. A common mistake is to forget the effective length factor K in the calculation of λ, which underestimates slenderness for any case other than pinned–pinned [^3].

Micro-check: True/False – A steel column with a slenderness ratio $\lambda = 50$ will fail by elastic buckling rather than yielding. *(Answer: False – 50 is relatively low; such a stocky column would yield before it buckles.)*

[^3]: For example, a column 3 m long with one end fixed and one end free has $K \approx 2.0$, so using $L = 3$ m alone underestimates its slenderness. The effective length is $K\,L = 2.0 \times 3 = 6$ m, so λ should be calculated with 6 m (not 3 m) in $K\,L/r$.

Variations & related forms:

- **Critical slenderness ratio:** Setting Euler's P_{cr} equal to the material's yield load ($A\sigma_y$) yields a threshold slenderness: $(KL/r)crit = \sqrt{\pi^2\,E/\sigma_y}$. Above this slenderness, Euler (buckling) governs; below it, material yield governs. (For example, plugging in typical steel values gives $(K\,L/r)_{crit}$ on the order of 80–100.)

- **Inelastic buckling (intermediate columns):** Real-world design uses empirical formulas like **Johnson's parabola** or reference curves (e.g. AISC column curves) for columns that are not slender enough for pure Euler. These formulas reduce the critical load below Euler's value to account for material yielding. On the FE Exam, you typically won't have to apply these, but remember that Euler's equation overestimates strength outside its ideal range.

- **Column design safety:** Sometimes a factor of safety is applied to Pin design. If you're asked for a safety factor against buckling on an exam, you would first compute P_{cr}, then divide this critical buckling load by the allowable or actual load. This isn't a new formula, just an application of Euler's result—but it reinforces that Euler's $P_{cr}$is a *theoretical* maximum capacity under ideal conditions.

Special notes: Because Euler's formula assumes an ideal elastic scenario, always interpret exam questions carefully. If a question describes a "short column" or says "neglect buckling," or if it provides material yield data but no E or I, that's a hint that buckling isn't the governing mode (the problem is likely about material failure instead). Conversely, if you see values for E, I, and a length with mention of "buckling" or "slender," that's your cue to use Euler's approach.

Explanation & Analysis: The assumptions behind Euler's formula define its **domain of validity**. On the FE exam, you might encounter a qualitative question like "Which of the following is an assumption in deriving Euler's column buckling formula?" or a problem where you must decide whether to use Euler's formula or a yield-based approach. Understanding these assumptions helps you avoid misapplying the formula:

- **Pinned ends & effective length:** Euler originally solved the buckling problem for a column with freely hinged (pinned) ends. If a column's ends aren't truly pinned or fixed, we adjust via K to approximate their effect. Assume no extra fixity or restraint beyond what K indicates. For instance, if a problem says a column is "fixed at the base and free at the top," you should think $K \approx 2.0$ (very weak support at the free end). If the problem doesn't explicitly give K, use the standard values for the described end conditions.

- **Elastic buckling vs. plastic yielding:** The slenderness ratio λ is your guide. For typical structural steel, roughly: $\lambda \gtrsim 100 \rightarrow$ likely elastic buckling governs; $\lambda \lesssim 50 \rightarrow$ likely yield (plastic) governs; in between, be cautious (intermediate behavior). The exam might not give you those numbers outright, but it could present data to clue you in. For example, if you compute P_{cr} and it comes out much higher than $A\sigma_y$, that's a red flag that the column would yield before reaching Euler buckling. In such a case, Euler's formula isn't the correct limit state to use – the material strength is the limit. Always check: if Euler's predicted P_{cr} is, say, 5 times larger than the force that would cause material yield, then the column is **not slender enough** for Euler's theory to apply in practice.

- **Recognizing intermediate cases:** While you won't need to calculate an intermediate formula on the FE, know qualitatively that an "intermediate column" fails by a mix of yielding and buckling. Euler's ideal curve overshoots the real strength. If the exam asks

what happens when a column's slenderness is reduced (making it less slender), the answer is that the Euler formula becomes less accurate and the actual failure load is lower (due to material yielding). Typically, the exam will expect: *Euler's formula overestimates the load capacity for intermediate or short columns.*

- **Practical visualization – short vs. long:** Imagine two columns made of the same material. One is very short and thick – like a squat steel post – and the other is very long and thin – like a slender rod. The short post might have an Euler P_{cr} calculation in the millions of newtons, but in reality it will **crush** (plastic yield) at a much lower load because it's too stocky to buckle. The long rod might have an Euler P_{cr} of just a few kN, and indeed it will buckle under a small load well before the material yields. Now consider an intermediate column: not extremely short, not extremely long. Euler's formula might predict, say, 200 kN, but the material's yield load $A\sigma_y$ is 150 kN. In practice, that column might fail around 150 kN or even a bit less, because once it yields, its stiffness drops and buckling follows. Euler's ideal 200 kN was never reached.

- **Takeaway for the exam:** Use Euler's formula when conditions are right: long, slender column, elastic range, and you're given E, I, etc. If the problem context suggests a stubby column or provides yield strength without mention of E or I, consider that the failure mode might be yielding, not buckling. And if a question asks about the assumptions of Euler's formula, recall the big ones: pinned ends (or known effective length), initially straight column, axial load with no eccentricity, linear elastic material, and a high slenderness ratio ensuring elastic buckling. Keeping these in mind will help you avoid applying the wrong formula and secure those easy points.

Topic 11 - Statically Indeterminate Systems

Topic Intro: *Statically indeterminate systems* are structural arrangements that cannot be solved using equilibrium equations alone. This topic matters on the FE Mechanical Exam because you must quickly tell if a structure has just enough supports (statically determinate) or extra supports (statically indeterminate) – and know how to handle that extra "redundancy." Typical questions might ask you to **classify a structure** (stable vs. unstable, determinate vs. indeterminate) or to **find a support reaction/internal force** in an indeterminate member using deflection compatibility. In short, you'll need to count supports and members, apply a **support-count check**, and possibly set up a **compatibility equation** to solve one extra unknown. Mastering these skills ensures you won't be fooled by seemingly simple supports or miss an extra equation on exam day.

K08.T11.S01 – Planar Truss Determinacy Criterion

Principle introduction – Planar **trusses** (pin-jointed structures like bridges or roof trusses) follow a simple relationship between the number of members and supports vs. joints:

Think of determinacy as a constraint-balance check: the count can come up short (suggesting a mechanism), exact (equilibrium is enough), or redundant (extra unknowns that require compatibility/deflection information).

To check a planar truss quickly: **count** members (*m*), supports (convert to reaction forces *r*), and joints (*j*). Then **compare** using the 2*j* rule (below). This *Count & Compare* move tells you the structure's status at a glance.

If you find *too few* members/supports (count comes out low), the truss is **unstable** (it can deform or collapse under load). If you find *too many*, it's **indeterminate** (extra support that makes it over-constrained).

Equation Passport: Planar Truss Determinacy
- Name and purpose: Planar Truss Determinacy Equation – checks if a **2D pin-jointed truss** has the right number of members and supports for stability. It tells you whether the truss is unstable, determinate, or indeterminate by comparing counts of unknowns and equations.

- Equation:

$$m + r = 2j$$

- Variables and units:

m = number of truss members (bars)
r = number of **independent** support reaction components (forces at supports that constrain motion; dimensionless count)
j = number of joints (where members connect; each joint is a pin allowing rotation)
(All are pure counts of structural features, unitless.)

- Assumptions and scope:

– Applies to **planar trusses** (2D trusses) with pin connections at joints. Each joint can sustain forces in two directions (x and y), giving *2j* possible equilibrium equations (ΣF_x and ΣF_y at each joint).
– All members are connected in a single network (no isolated parts) and supports prevent rigid body motion. **Geometric stability** is assumed (the truss isn't a mechanism; see footnote).

– Only **static** support reactions count for *r* (exclude internal hinges, which aren't supports). For a pin support, count 2 reaction forces; for a roller support, count 1 (vertical reaction usually); no moments resisted in a pin-jointed truss support.

- Limit tests (sanity checks):

- Count interpretation (narrative): Define Δ = m + r − 2j. Δ summarizes the constraint balance: the magnitude |Δ| tells you how far the truss is from the "just-enough" count, and the sign tells you whether you have redundancies (Δ>0) or a likely mechanism due to insufficient constraints (Δ<0). Δ=0 is the borderline equilibrium-solvable count, assuming stable geometry and supports that prevent rigid-body motion.

- Use vs. sibling equations: Use this truss equation for structures of pin-connected straight members (two-force members) where joints allow rotation. Do not use it for rigid frame structures (where joints resist bending) – for those, use the frame equation (see next subtopic). Likewise, for 3D trusses (space trusses), the form changes (3j in place of 2j) because joints have three degrees of freedom in space – but 3D cases are beyond typical FE scope.

Common exam traps:

– **Miscounting supports**: Ensure you count each independent reaction. Exam hack: Pin support = 2 reactions (usually one horizontal, one vertical); Roller = 1 (vertical only); if a support is pinned but on a surface that prevents vertical movement only, still count horizontal if applicable (often one direction is intentionally free like a roller). Don't forget to count all supports in total r.

– **Ignoring geometry**: The formula gives a necessary count, but stability also requires the structure's geometry to be non-degenerate. For example, three collinear pins with members between might satisfy m+r = 2j but can still fold (unstable) because all joints lie on a straight line. [^geometry]

– Extra members that don't add stiffness: Sometimes an extra member may appear to make m+r > 2j, but if that member is redundant and not properly connected (like two members connecting the same joints), it might not actually constrain anything (no new equation or no effect due to collinearity). Be wary of counting elements that don't change stability.

– Overcounting joint count: Only count actual joints where members meet. A support location where a member ends is also a joint, but if two members overlap without a connection, that doesn't count as a joint for j.

Exam Handbook Search Cues (Not affiliated with or endorsed by NCEES): "statically indeterminate", *m + r = 2j*, "truss determinacy", "members, joints, supports count", "stability of truss"

Variations and related forms: For a **3D truss** (space truss), the analogous determinacy condition is $m + r = 3j$ (each joint has 3 force equilibrium equations in 3D). For most FE Mechanical problems, you'll stick to planar structures. The **degree of indeterminacy** (redundant count) for a planar truss can be calculated as $m + r - 2j$. For example, if $m + r = 2j + 2$, the truss is **2° (second-degree) indeterminate**, meaning you'd need two additional compatibility equations to solve it. Typical stable trusses (like simple triangles, bridges with just enough diagonal bracing) are determinate. Adding even one extra bar or support turns them indeterminate (which can make them stronger or more redundant in real life, but trickier to analyze on exam).

Special notes: No complex calculations are usually needed for the determinacy check – it's a counting exercise. Make sure to perform the count carefully; use a systematic approach (list out members, list out support reactions, list joints) to avoid mistakes. You won't need a calculator except for basic arithmetic (which the exam calculators handle easily).

Explanation & analysis (step-by-step): A planar truss is essentially a network of joints connected by members. Determinacy is about the balance between **unknown forces** and **available equations**:

Equilibrium Equations: In a pin-jointed truss, each joint can have forces balance in two directions (horizontal and vertical). If you write out equilibrium at every joint, you get about $2j$ equations in total (minus some redundant ones equivalent to whole-structure equilibrium). This $2j$ is the maximum number of independent equations you can get from joint equilibrium in a planar truss. [^whole] On the support side, the entire structure also has up to 3 global equilibrium equations (ΣF_x, ΣF_y, ΣM), but those can be derived from the joint equations too. So $2j$ is a good count of independent conditions for internal forces plus supports in a truss.

Unknowns: The unknowns in a truss are the member forces (each member carries an unknown tension/compression) and the support reactions (forces at supports). There are *m* members (so *m* member force unknowns) and typically *r* support reaction unknowns. For a determinate, stable truss, every unknown can be found by solving an equilibrium equation. That's why the magic number is $m + r = 2j$. If this equation holds, **number of unknowns = number of independent equations**, so you can solve for all forces and reactions uniquely.

Use Δ = m + r − 2j as the organizing idea. A negative Δ typically corresponds to a mechanism (some part can move without stretching members), while a positive Δ means there are Δ redundant unknowns that require Δ compatibility/deflection relations in addition to equilibrium. When Δ=0, equilibrium closes the system in principle—but still sanity-check the layout (triangulation/non-collinearity) and the support arrangement to ensure the truss cannot move as a rigid body.

Finally, always double-check the **support arrangement**. Even if the count fits, a weird support layout (e.g., all supports on one hinge or all supports in a straight line) can cause a slip or rotation that isn't obvious from counting. As a rule of thumb, supports should not all allow the structure to move in a particular direction. If they do, the structure might slide or rotate freely – an instability the simple formula didn't catch. Always ask: *"Could this thing hold itself up in reality?"* If something seems fishy (like a structure that would tip over or collapse if nudged), chances are it's unstable in practice despite any count.

[^whole]: *Whole-structure vs joint equilibrium:* In a determinate truss, solving via joint equilibrium or whole-structure equilibrium is equivalent. The $2j$ count comes from summing joint equations, but note that the whole structure has only 3 independent equilibrium equations. The rest of the $2j - 3$ equations basically solve for internal member forces. The condition $m + r = 2j$ ensures those internal force equations are just enough (no under- or over-determined system).

K08.T11.S02 – Planar Frame Determinacy Criterion

Principle introduction – Planar **frames and beams** (structures with rigid or fixed joints that resist bending) have a different equation for determinacy because each joint can also resist rotation. In a **rigid frame**, members aren't pin-connected; they hold angles between them. This adds more possible equilibrium equations (moments) – but also more unknowns (fixed joints transfer bending moments). Key ideas:

- A **plane frame** (or a single beam with fixed supports) has rotational stiffness at joints, so each joint provides an extra equilibrium condition (moment equilibrium) beyond the two force balance equations.
- The determinacy criterion for frames uses a ***3j*** term instead of 2*j* (reflecting three equations per joint: ΣF_x, ΣF_y, ΣM).
- The check is the same idea as for trusses: compare "unknowns you must solve for" to "independent equilibrium/condition equations available" to see whether the model is short on constraints, just constrained, or has redundancies.
- **Internal hinges** or known internal releases (points where bending moment is zero by design) reduce the effective constraints; they introduce *condition equations* (noted as *c* in the formula). Essentially, each internal hinge removes one moment equation, altering the count.
- **Shortcut:** For a simple beam or frame, count each **member** (*m*), each **support reaction** (*r*), and each **joint** (*j*). If any internal hinge (moment release) exists, note *c* (each hinge gives a known zero moment condition that effectively provides an extra equation or reduces a constraint, depending on perspective). Plug into the 3*j* formula below to judge stability/determinacy.

Equation Passport: Planar Frame Determinacy

- Name and purpose: Planar Frame (Beam) Determinacy Equation – determines if a 2D structure with rigid connections (frames or beams with fixed supports) is stable, determinate, or indeterminate. It accounts for translational and rotational equilibrium at joints and includes any internal hinge conditions.

- Equation:

$$3m + r = 3j + c$$

- Variables and units:

m = number of members (beams or frame elements)
r = number of independent support reaction components (count forces **and** moments reacted at supports)
j = number of joints (where members connect rigidly or where members meet supports)
c = number of known *condition equations* (typically, internal hinges or releases where the bending moment is known to be zero,

providing an extra equation or reducing one unknown moment transfer)

(All are counts, unitless.)

- Assumptions and scope:

– Applies to **planar frames, beams, or any rigid-joint 2D structure**. Each joint in a rigid frame can impose three equilibrium conditions (force in *x*, force in *y*, and moment). If a joint connects two or more members rigidly, their rotations are linked (no hinge there).

– Support reactions (*r*) must include **moment reactions** at fixed or clamped supports. For example, a fixed support in 2D counts as 3 reaction components (*H*, *V*, and a moment *M*), a pin counts as 2 (*H* and *V*), a roller counts as 1 (*V* if it only resists vertical).

– *c* accounts for *internal hinges* (or any intentional releases). An internal hinge means the bending moment at that joint is zero and the two connected members can rotate freely relative to each other. This condition provides an equation (M = 0 at that hinge) that effectively increases the count of available equations (or reduces the unknown moment transfer). Each internal hinge generally adds 1 to *c*.

– The structure should be one connected piece (ignoring isolated parts). Also, as with trusses, a "sufficient and proper arrangement" of supports is assumed (no unintended free body motions).

– Count interpretation (narrative): Define Δ = 3m + r − (3j + c). Δ is the "by-count" indeterminacy measure: positive values indicate redundancies (need Δ compatibility relations beyond equilibrium), negative values suggest missing constraints (a mechanism/free motion is likely), and Δ=0 is the borderline equilibrium-solvable count—assuming the frame is properly supported and laterally stable.

- Use vs. sibling equations: Use this for any **beam or frame problem** where joints or supports resist moments. If a structure has all **pin connections** (no moment resistance at joints), it's essentially a truss and the truss formula (previous subtopic) applies. If the structure is a bridge or frame with some pin connections and some rigid, you may need to apply this thinking segment by segment or consider internal hinges via *c*. For **3D frames**, the concept extends (each rigid joint in 3D can have 6 equilibrium equations), but those are beyond the FE Mechanical scope.

- Common exam traps:

– **Forgetting moment reactions:** A fixed support's moment reaction counts as an unknown! Many exam-takers count only forces and forget that if a beam is fixed or clamped, the reaction moment is another unknown to include in *r*. Don't leave out rotational support constraints.

– **Misidentifying joints:** In a continuous beam (say spanning over two supports), if it's one piece, the supports themselves act like "joints" in the sense of dividing members? Actually, treat each span between supports as a member (*m*= number of spans), and count the connections at supports too. For a continuous beam over three supports, *m*=2 (two spans), *j*=3 (supports and ends considered joints: left end, middle support, right end). It's easy to confuse *m* vs *j* in continuous structures – always count member pieces and connection points distinctly.

– **Internal hinge counting:** If the frame has a hinge (like a pinned connection in the middle of a beam or a "hinge" in a frame leg), remember to set *c*=1 for each hinge. This improves the equilibrium count. Example trap: A frame looks indeterminate by count, but the presence of a hinge could actually make it determinate if you include *c*. Conversely, forgetting *c* would make you think it's indeterminate when it's not.

– **Stability with all supports pinned:** A rigid frame needs at least one support that resists rotation *or* some configuration to prevent it from simply rotating as a whole. If you have a frame with all supports as pins (no fixed base), check stability carefully. The count might satisfy $3m + r = 3j$, yet the frame could sway as a mechanism. The formula assumes the structure won't just pivot or sway – make sure there's something (like a diagonal brace or a fixed support) to prevent a global rotation. This is the frame equivalent of the geometry caveat for trusses.

Exam Handbook Search Cues (Not affiliated with or endorsed by NCEES): "plane frame stability", "3m + r = 3j + c", "reactions and joints count", "internal hinge (zero moment)"

Variations and related forms: In a **continuous beam** (which is a type of frame along a line), the same equation applies. For example, a continuous beam over multiple supports can be seen as a frame with no vertical members. Each span is a member; each support (plus the two ends) is a joint. The degree of indeterminacy can be found with $3m + r - (3j + c)$. For a quick shortcut in simple cases: often each extra fixed support or continuous restraint adds that many degrees of indeterminacy. For instance, by full 2D reaction count, a fixed–fixed beam is 3° indeterminate; in many bending-only vertical-load cases it's commonly treated as 2° (two redundant end moments). A two-span continuous beam (no hinges) is indeterminate to 1 degree (one extra moment equation needed beyond statics). These match the formula outcomes. Another variation: **Pinned-base frames** vs **fixed-base frames** – a pinned-base frame (columns pinned at base) will have fewer reaction moments (r is smaller) and might actually be determinate where a similar fixed-base frame is indeterminate. Always apply the count carefully to whatever support conditions are given.

Special notes: Solving frame indeterminacy often requires methods like moment distribution or the force method in practice – but on the FE exam, you typically won't do a full multi-degree indeterminate solution by hand (too time-consuming). Instead, you might be asked whether it's indeterminate or to solve a simplified case (like one redundant) using deflection formulas. Be ready to use the compatibility approach for one redundancy (next subtopic). When using the calculator, solving these count equations is straightforward. If you have to actually compute a redundant reaction, ensure you input any deflection formulas correctly (use the provided beam tables from the handbook, if needed) and be mindful of unit consistency (e.g., inches vs feet in modulus *E* or moment of inertia *I*).

Explanation & analysis (step-by-step): The formula $3m + r = 3j + c$ might look intimidating, but it's just an extension of the logic from trusses, with rotation thrown into the mix:

Equations available: In a rigid frame or beam system, each joint can satisfy force equilibrium in the x and y directions and also moment equilibrium. That's up to 3 equations per joint, hence the $3j$ term. If a joint is at a support, some of those equations overlap with global equilibrium, but it's a convenient count. The extra term *c* comes from internal conditions: an *internal hinge* is essentially a place where we know the bending moment must be zero. That's like an extra equation (or a removed unknown) because it's a

known condition within the structure. So effectively, total independent equations = $3j + c$.

Unknowns to solve: Unknowns include: internal forces in members (axial, shear, bending in each member). However, a more straightforward count is: each member contributes internal forces between joints, but if we count m as number of members, internal force unknowns are implicitly handled by considering joints and member equilibrium. For external unknowns, count support reactions r (including force and moment reactions). The term $3m$ in the formula accounts for the internal force unknowns in a way: each member in a planar frame can have up to 3 internal force components (axial, shear, moment at a cut). But rather than break those out, using $3m$ + r is a known shortcut to represent total unknown force components in the system (it originates from an analysis of degrees of freedom method, but no need to derive here).

Putting the count to work: After you tally m, r, j, and any releases c, form Δ = 3m + r − (3j + c). Δ tells you whether equilibrium closes the system by itself or whether you have leftover unknowns that require compatibility. Keep one extra gut-check in mind that the count doesn't guarantee lateral stability (e.g., a sway mechanism can exist if supports don't restrain horizontal motion). Quick anchors: a simply supported beam (m=1, j=2, r=3, c=0) gives Δ=0; a propped cantilever (m=1, j=2, r=4, c=0) gives Δ=1.

Unstable scenario insight: If $3m + r < 3j + c$, something's not held in place. A simple example: a **cantilever beam with no support at the free end** is fine (determinate), but a **beam with only one end pinned and the other end free**: m=1, j=2 (free end and pinned end), r=2 (pin has 2 reactions), c=0, so $3 + 2 = 5 < 6$. The beam will rotate down because the free end isn't supported – unstable. Another example: a rectangular frame supported only at one lower corner (a single pin) – obviously it would topple, and the count reflects that deficit. For the exam, you rarely have to compute counts for clearly unstable setups – more often, they might test if you recognize a structure can sway. For instance, a frame with pin supports at both bottom corners (no horizontal restraint) can sway sideways even though count might equal. The formula says 3m+r=3j but *caveat*: lateral stability is missing. Thus always accompany the math with a quick stability gut-check.

Indeterminate scenario insight: If $3m + r > 3j + c$, we have more unknowns than equations – redundancies. A **fixed-fixed beam** is a classic: It has one extra redundant moment at one end (or you could say two extra if counting both ends, giving degree 2 or 3 depending on how you consider the global equilibrium). With these extra unknowns, we can't solve everything with just statics. For a fixed-fixed beam under a load, you'd normally use deflection symmetry or beam tables (from strength of materials) to find the reactions. The FE Handbook provides formulas for fixed-end moments and such, because these come from solving compatibility (beyond equilibrium). Another example: a two-span continuous beam (like two spans continuous over a middle support) has one redundant moment at the middle support (thus indeterminate to 1). In exam context, they might give you the value of that support moment via a table or ask conceptual questions like "Which support reaction is larger in a continuous beam vs a simply supported beam with the same load?" (Because indeterminacy changes distribution).

So, use the formula to identify the class: unstable (no unique solution, mechanism), determinate (solvable by statics), or indeterminate (needs extra steps to solve). Once identified, if it's indeterminate but only by 1 degree, you might be expected to set up a compatibility equation – that's where we move next.

K08.T11.S03 – Single-Redundancy Force Method (Compatibility Equation)

Principle introduction – When a structure is *statically indeterminate by one degree* (only one extra unknown), you can still solve it with a bit of **mechanics of materials magic**: introduce a *compatibility condition* using deflections. This is the essence of the **Force Method for one redundant** support or member force:

- **Redundant support/member:** Choose one extra reaction or internal force to temporarily treat as unknown (the *redundant*). *Remove* that support or cut that member, making the structure statically determinate (free it up).
- **Deflection from loads:** Analyze the now-determinate structure under the original loads (with the support removed or member cut). Compute the deflection at the location of the removed support (or relative deformation where the cut member was).
- **Deflection from the redundant:** Next, apply an isolated force (or moment) at the location of the removed support (or a force in the cut member) – this force represents the unknown redundant reaction. Calculate how much deflection that force alone causes at that point.
- **Compatibility (zero net deflection):** Finally, **set the total deflection to zero** at the redundant location: the actual structure didn't move there (because the support is actually present or the member is uncut), so the deflection caused by the actual loads plus the deflection caused by the redundant reaction must cancel out. Solve this equation for the redundant force.
- In short, *"deflection due to loads"* + "deflection due to redundant reaction" = 0*. This yields the value of the redundant reaction. Once you have that, you can plug it back in to find other forces if needed.
- This method requires knowing how to get deflections (via formulas or tables for beam deflections, etc.), but the FE exam provides common deflection formulas in the handbook. Recognize keywords like "force method" or "redundant support" – that's your cue to use compatibility.

Definition/Note Passport: Redundant Support Compatibility

- **Plain-language definition:** A **redundant support** is an extra support (or restraint) that isn't needed for basic equilibrium. Removing it wouldn't make the structure collapse (it would just deform more). The **compatibility equation** ensures that when the support is actually present, the deflection at that point is zero. In one sentence: *We remove the extra support, find how much the structure would deflect, then apply a force to push it back up to zero – the amount of force needed is exactly the support's reaction.*

- **Where it matters (exam impact):** You'll use this concept in problems like "a propped cantilever beam" or "a beam with three supports." The exam might give you a beam with an extra support and ask for a reaction at that support or the bending moment somewhere. You're expected to set up the deflection equation or recall the result from known cases. Another scenario is a two-rod system (load shared by two materials) – that also uses compatibility (equal deformation in both rods). Essentially, any time there's an extra unknown, think *compatibility*: some deformation condition replaces the missing equation of equilibrium.

- **Pitfall or confusion point:** The biggest mistake is **sign convention** – when setting deflections to zero, make sure one deflection is taken as negative if it's in the opposite direction. For

example, if a downward load makes the beam sag down at the support by Δ, the redundant reaction would cause an *upward* deflection δ at that point; the compatibility condition is Δ (downward, take as positive in that direction) + δ (upward, which might be negative in the same sign convention) = 0. In practice, many just set magnitudes equal and intuitively understand one is opposing the other. Another pitfall: forgetting to use the *correct deflection formula* for the specific case. Always double-check you're using the deflection for the correct loading and beam conditions (i.e., for the structure *with the support removed*, which might be a different span length or end conditions than the original).

- **Micro-check:** *True/False:* "In a statically indeterminate beam, if you remove one support and find that point deflects 5 mm under the given load, you must apply a support reaction that would deflect the beam *−5 mm* at that point (in the opposite direction) to restore the support's position." **True.** (This is the core of compatibility: equal and opposite deflections.)

Exam Handbook Search Cues (Not affiliated with or endorsed by NCEES): "force method", "redundant support deflection", "compatibility equation", "statically indeterminate beam"

Variations and related forms: The single-redundant force method can be generalized to multiple redundants (then you'd have a system of equations), but the FE Mechanical Exam usually limits to one degree indeterminacy. A common **variation** is thermal expansion problems: for example, a rod fixed at both ends that is heated. There, the "redundant" is the reactive force developed in the rod, and the "deflection if free" is just the thermal expansion (Δ = αΔT L). Setting total expansion to zero (because the ends don't move) lets you solve the force just like the support example. Another related scenario is two springs or two bars in parallel sharing a load – compatibility says they shorten by the same amount, which lets you find the force in each (again an indeterminate problem solved by matching deformations). These all hinge on the same principle: impose the condition that deformations must match reality (no gaps, no overlaps).

In beam problems, you might also encounter the idea of **superposition** as a form of this method: e.g. find deflection from load alone, find deflection from an unknown reaction alone (often using simpler sub-cases), and add them. If the structure is supported at that point, sum = 0. The method of superposition with deflections is essentially the force method in action.

Special notes: When typing these calculations in the calculator, break it down: find the deflection from load (using formula, which might involve E, I, etc.), find the deflection from a unit load at the redundant (often you scale it by the actual unknown later), then solve for the unknown by setting $\Delta_{\text{load}} + \Delta_{\text{reaction}} = 0$. It's easy to make algebra mistakes, so keep track of each piece. Units must be consistent (if deflections are in inches, forces in kips, E and I in consistent units, etc.). The exam will often give deflection formulas, so you might not need to derive anything – just plug in.

Explanation & analysis (step-by-step): Let's apply the **force method** step by step on a classic example: a **propped cantilever beam** (fixed at one end and simply supported at the other) subjected to a uniform distributed load. This beam is indeterminate to 1 degree (one extra support reaction at the simple support). How to find that reaction?

1. **Identify the Redundant:** The extra support (the roller at the free end, say Point B) provides a vertical reaction R_B that is not solvable by statics alone. We label that reaction as the *redundant* unknown. If we "remove" that support, the beam becomes a simple cantilever (fixed at A, free at B) which *is* statically determinate.

2. **Remove the Redundant (Temporary Structure):** Imagine the beam with the roller support gone – so the beam is just fixed at A and free at B. Under the given uniform load *w*, this beam will **deflect downward** at Point B. Using beam deflection formulas (from the exam handbook or known mechanics formulas), we compute the deflection at B due to the load *w*. For a uniform load on a cantilever of length L, the deflection at the free end is $\Delta_{B,\text{load}} = \frac{wL^4}{8EI}$ downward (assuming A is fixed and downward is positive deflection). This is how far B would sag if it weren't held up.

3. **Apply the Redundant Load:** Now, put the support back in theory by applying an upward force R_B at point B (upward, because a roller support can only push up). We consider this force *alone* on the beam (no uniform load, just that upward force at B on an otherwise cantilevered beam). How much deflection does R_B cause at point B? For a cantilever of length L with an upward force *P* at the free end, the deflection at the free end is $\delta_{B,\text{force}} = \frac{PL^3}{3EI}$ upward (upward force causes upward deflection). If we put $P = R_B$, then $\delta_B = \frac{R_B L^3}{3EI}$ upward at point B.

4. **Compatibility Equation (Zero Deflection at B):** In the real structure (the propped cantilever), point B doesn't actually move – it's supported. So the **net deflection at B must be zero**. Using sign convention (say downward deflection is positive for the load case), the load caused a downward deflection $\Delta_{B,\text{load}}$ and the reaction causes an upward deflection $\delta_{B,\text{force}}$. To cancel, we set:

   $$\Delta_{B,\text{load}} + \delta_{B,\text{force}} = 0.$$

   Substituting the expressions:

   $$\frac{wL^4}{8EI} + \left(\frac{R_B L^3}{3EI}\right)(-1) = 0,$$

   (Here I've treated upward deflection as negative relative to downward). Solve for R_B:

   $$\frac{wL^4}{8EI} = \frac{R_B L^3}{3EI}$$

   $$R_B = \frac{wL^4}{8EI} \cdot \frac{3EI}{L^3} = \frac{3wL}{8}.$$

   So the redundant reaction at B is $R_B = \frac{3}{8}wL$ (for a uniform load, that means this support carries 3/8 of the total load *wL*). The other 5/8 would be at the fixed end's reaction, if you check equilibrium (indeed, fixed end vertical reaction would be 5/8 *wL* upward and there'd be a moment too).

You didn't have to memorize that result – you derived it using compatibility. On the FE exam, you could also get this by looking up tables: the handbook might directly give you the reaction

fractions for a propped cantilever with uniform load. But knowing the *principle*, you can handle any one-degree indeterminate scenario by forming a similar equation.

Double-Check Equilibrium: After finding R_B, it's wise to verify it with equilibrium as a sanity check. In our example, total load = wL. Sum of vertical forces: $R_A + R_B = wL$. If $R_B = 3/8wL$, then $R_A = 5/8wL$. No issue. Moment about A: $M_A = R_B \cdot L - w \cdot (L)(L/2)$. Substituting R_B gives $M_A = \frac{3}{8}wL \cdot L - wL \cdot \frac{L}{2} = \frac{3}{8}wL^2 - \frac{1}{2}wL^2 = \frac{3-4}{8}wL^2 = -\frac{1}{8}wL^2$. The negative sign indicates the moment at A is counterclockwise (depending on sign convention) – consistent with the fixed end resisting the load. The exact value isn't as important for us, but if we needed internal moments, we could get them now.

This **force method** process is powerful. You essentially break a tough problem into two easier deflection problems, then combine them. Always remember: the redundant force opposes the deflection that would have occurred without it. In any scenario (beams, frames, composite rods), think: *"What happens if I remove the extra support/constraint? How do I enforce it back?"* That enforcement is your compatibility condition. If you keep that logic straight, statically indeterminate questions become very manageable instead of mysterious.

DON'T MOVE ON YET!

Work Through Some Solid Practice Problems
while the Material of this Knowledge Is Still Fresh
THIS IS HOW THE CONCEPTS LOCK IN.

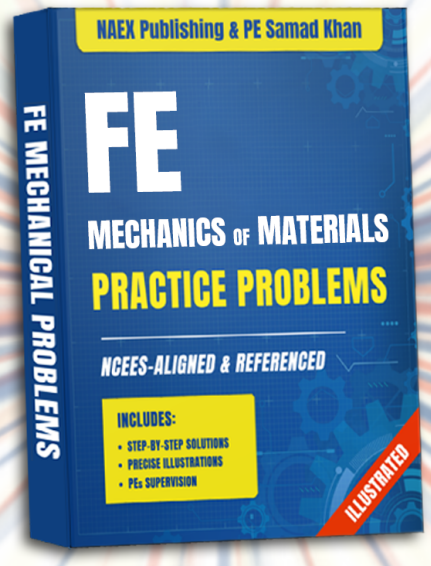

CLICK HERE TO PRACTICE

You'll be taken to our Discord Server, where the problems are located.

KNOWLEDGE 09

MATERIAL PROPERTIES AND PROCESSING

- NAEX Publishing -

"This publication is not affiliated with or endorsed by NCEES".

Topic 01 - Properties

Topic Introduction: In the FE Mechanical Exam, you'll face questions about material properties – the intrinsic characteristics that determine how materials behave under various conditions. This topic covers **chemical, electrical, mechanical, and thermal properties of materials**, and knowing these helps you choose the right material or predict performance in design problems. Typical questions might include selecting a material that **resists corrosion**, calculating deformation using **stress–strain relationships**, comparing **thermal expansion** between materials, or using a property table to find a material meeting certain criteria. Essentially, you'll apply these properties to solve practical engineering scenarios – from preventing a steel beam from rusting away, to ensuring a shaft won't fracture when a crack is present. Mastering this topic means you can quickly identify which property (or formula) to use and avoid common pitfalls (like mixing units or confusing similar terms) on exam day.

K09.T01.S01 – Chemical Properties and Corrosion

Principle (Corrosion Fundamentals):

- **Corrosion** is the gradual loss of a material—most often a metal—because it reacts with its surroundings. In wet or conductive conditions, different areas on the surface can act as reaction sites: at anodic spots the metal dissolves into ions (oxidation) and releases electrons, and those electrons move through the metal to cathodic spots where a reduction reaction consumes them (commonly oxygen reduction, or hydrogen evolution in acidic environments). The electrolyte provides the ion pathway that balances charge and allows the process to continue.

- Common example: **rusting of iron** – Fe atoms oxidize to Fe^{2+} at the anode, and oxygen is reduced (with water) at the cathode producing OH^-; these combine to form iron hydroxides/oxides (rust).

- Material **corrosion resistance** depends on chemistry: some metals form protective oxide layers (e.g. aluminum's Al_2O_3 or stainless steel's chromium oxide) that slow further corrosion, while others corrode readily (e.g. untreated steel). Alloying and coatings can greatly improve resistance.

- Corrosion is **electrochemical**. Dissimilar metals in contact create a galvanic cell: the more **active** (less noble) metal becomes the anode and corrodes, while the more noble metal is protected as the cathode. For example, if zinc and steel touch in saltwater, zinc (anode) corrodes preferentially, protecting the steel – this is the principle of **sacrificial anodes**.

- **Environment** matters: higher temperature, presence of salts or acids, and stress can accelerate corrosion. Conversely, removing electrolytes (dry conditions) or using inhibitors can reduce corrosion. Engineers use cathodic protection, coatings (paint, plating), or material selection (stainless steel, non-corroding alloys) to control corrosion.

Exam Handbook Search Cues (Not affiliated with or endorsed by NCEES): corrosion, anode, cathode, oxidation, reduction, galvanic series, rust

Footnotes:

- *Units:* Corrosion rates might be expressed in mm/year or mpy (mils per year). Ensure you convert time and length units if needed (though exam problems often describe qualitatively).

- *Scope:* The FE exam won't expect detailed electrochemistry calculations, but understanding which metal corrodes in a pair, or how to mitigate corrosion, is fair game.

- *Terminology:* "Oxidation" in corrosion means loss of electrons (not necessarily reaction with oxygen gas – e.g. in acids, iron oxidizes to Fe^{2+}). Remember **OIL RIG** – Oxidation Is Loss, Reduction Is Gain (of electrons).

- *Why Students Slip:* Don't confuse **corrosion resistance** with hardness or strength – a strong alloy might still corrode fast if it's electrochemically active. Also, **passivation** (forming a protective film) is why aluminum and stainless resist corrosion; scratching through the film can localize corrosion (pitting).

Variations and Related Forms:

- **Galvanic series:** a practical list of materials ranked by nobility in a given environment (e.g., seawater). Metals near the anodic end corrode preferentially when coupled with metals near the cathodic end. Use this series qualitatively – no calculations, just comparative behavior.

- **Typical corrosion behavior:** Ferrous metals (iron, steel) corrode by rusting unless protected; copper alloys tarnish but form stable patina; noble metals (gold, platinum) barely corrode; aluminum forms a protective coat (white aluminum oxide).

- **Other forms of corrosion:** Be aware of terms like *pitting* (localized attack), *crevice corrosion*, *stress corrosion cracking*, and *uniform corrosion*. The FE might include conceptual questions on these if they appear in the reference material. Focus on the idea that environment + stress can create specific corrosion modes (e.g. chlorides cause pitting in stainless steel).

Special Notes: Corrosion equations aren't typically entered into your calculator, but you may need to do simple arithmetic for corrosion allowance (like **thickness loss over time**). For example, if a pipe loses 0.1 mm/year, over 20 years that's 2 mm – ensure unit consistency (convert years to the same time basis if needed).

Explanation & Analysis: Corrosion matters on the exam because you might be asked which material to choose for a given environment, or which metal in a pair will corrode. The fundamental principle is the **anode-cathode** mechanism: the anode metal gives off metal ions (eroding away), and the cathode surface consumes electrons (often by reducing oxygen or water). You should remember that *corrosion requires an electrochemical circuit*. Physically, that means electrical contact plus an electrolyte. If any part is missing – say the metal is perfectly dry or insulated – corrosion slows or stops. This is why **design against corrosion** might include breaking the circuit (insulating dissimilar metals, sealing out water, or applying coatings).

Let's break down a typical scenario: **dissimilar metal corrosion.** Imagine a steel bolt in a copper plate exposed to seawater. Steel is less noble than copper, so steel becomes the anode and will corrode (iron dissolving into ions) while copper (cathode) remains intact.

The saltwater enables ion flow. If you wanted to prevent the steel bolt from corroding, you could attach a piece of zinc (even less noble) nearby – the zinc would corrode instead (sacrificial anode principle). On exam day, a question might give you a series of metals and ask which one to use as a sacrificial anode for iron – you'd pick a metal that is more active than iron (e.g. zinc or magnesium).

Also remember **corrosion resistance** isn't just about the galvanic series: alloys like stainless steel resist rusting not because they are noble (iron isn't) but because of a thin chromium oxide film that self-heals. If the exam asks why stainless works or why aluminum doesn't corrode through, the answer is *passivation*.

Finally, think safety: corrosion can lead to failures (burst pipes, bridge collapses), so engineers use allowances (extra thickness) and inspections. For the FE exam, keep it simple: identify anode vs cathode, and know that the anode metal is the one that **corrodes**.

Quick micro-check: If you dip a strip of magnesium and a strip of copper into saltwater and connect them, which becomes the anode?[1]

K09.T01.S02 – Electrical Properties (Permittivity, Capacitance, Resistivity, Conductivity)

Principle (Electrical Material Properties):

- Many FE problems involve **capacitors or resistors** made of materials, so knowing how material properties like permittivity and resistivity enter basic formulas is key.

- **Permittivity (ε)** describes how readily a material supports an electric field; i.e., how much charge it can store as a dielectric. It is related to the dielectric constant (relative permittivity) κ by $\varepsilon = \kappa\varepsilon_0$, where ε_0 is the permittivity of free space $\approx 8.85 \times 10^{-12}$ F/m. Materials with larger κ (for example, water $\sim 80$and many ceramics ~ 5–100) act as better dielectrics, storing more charge for a given electric field. Air or vacuum has $\kappa = 1$ as the reference value.

- **Capacitance** of a capacitor depends on geometry and permittivity. For a simple parallel-plate capacitor (two plates facing each other): capacitance **increases** with plate area and material permittivity, and **decreases** with plate separation.

- **Resistivity (ρ)** is a material property indicating how strongly a material opposes electric current. It's the reciprocal of **electrical conductivity (σ)**: a low ρ (high σ) means the material conducts well (metals), while a high ρ (low σ) means it's an insulator (ceramics, polymers).

- **Conductors vs insulators:** Metals (e.g. copper, aluminum) have very low resistivity (~10^{-8} Ω·m), enabling electrons to flow easily; good insulators (pure glass, Teflon) have resistivities 10^{10}–10^{20} times higher, effectively blocking current. Semiconductors fall in between and can vary their conductivity with doping, but for FE Mechanical focus on extremes (conductors vs insulators).

- When solving exam problems: use **C = εA/d** for capacitance of parallel plates, and **R = ρL/A** for resistance of a uniform specimen. Keep track of units: permittivity in F/m, area in m², distance in m gives C in farads; resistivity in Ω·m, length in m, area in m² gives R in ohms. A common mistake is mixing up ρ (material property) and R (component's resistance).

Equation Passport – Parallel-Plate Capacitance
Capacitance of a Parallel-Plate Capacitor – computes the capacitance C stored between two plates with a dielectric

$$C = \frac{\varepsilon A}{d}$$

Variables and Units:

- C = capacitance, ability to store charge (SI unit: **farad (F)**).
- ε = permittivity of the material between plates (F/m). Often written as $\varepsilon = \kappa\varepsilon_0$, where κ is dimensionless dielectric constant, $\varepsilon_0 = 8.85 \times 10^{-12}$ F/m.
- A = area of one plate (m²). Larger area → more capacitance (more room for charge).
- d = separation between plates (m). Larger gap → less capacitance (weaker field coupling).

Assumptions and Scope:

- The formula assumes a **uniform field** between plates (good for parallel flat plates, negligible fringing). It assumes the dielectric completely fills the space between plates and is homogeneous.

- **Linear dielectric:** the material's permittivity is constant (no voltage-dependent effects) – true for most materials at moderate fields (as on the FE exam).

- No edge effects: in reality, fields fringe at the edges, but exam problems either ignore this or assume an "ideal capacitor" as given by this formula.

Limit checks:

- If plate separation $d \to 0$ (plates almost touching), $C \to \infty$. That makes sense: it takes virtually no voltage to store charge when plates are extremely close. In real life, you'd get a spark (breakdown) before truly infinite capacitance, but mathematically the trend holds.

- If plate area $A \to 0$, then $C \to 0$. A tiny plate can't hold much charge – reasonable.

- As κ (thus ε) increases, C increases. e.g., inserting a dielectric with κ = 5 multiplies capacitance by 5 compared to air. If κ→0 (a hypothetical perfect vacuum with no field lines – not physical), C→0.

Use vs. Sibling Equations: Use this parallel-plate equation instead of more complicated capacitance formulas when the capacitor geometry is simple parallel plates (common in FE problems). If you had a cylindrical capacitor or spherical capacitor, there are different formulas (provided in the handbook if needed), but the exam most often sticks with parallel plates or gives you effective values.

Common exam traps:

- **Unit mix-ups:** Area must be in m² and distance in m for ε (F/m) to work out. If area is given in cm² or distance in mm, convert to SI before plugging in, or your capacitance will be off by orders of magnitude.

- **Using κ instead of ε:** Sometimes data gives dielectric constant κ. Remember to multiply by ε_0 to get ε for the formula. For example, "a material with dielectric constant 4" means ε = 4 × 8.85×10^{-12} =

3.54×10^{-11} F/m. Don't mistakenly plug "4" in place of ε – 4 F/m would be an enormous permittivity (air is only 8.85×10^{-12})!

- **Spacing vs thickness:** If a problem describes a capacitor with a dielectric **thickness** = d, that is the separation between conductive plates. Ensure you identify the correct distance. If multiple layers of dielectric or series capacitors are present, the effective capacitance might require the series/parallel formula – but that's an electrical circuits application (likely in a different exam section).

Related Form – Electrical Resistivity and Conductivity: For a uniform piece of material (think of a wire or a bar) used as a resistor, the resistance is determined by the material's resistivity:

$$R = \rho \frac{L}{A}$$

Here R is resistance (Ω), ρ is resistivity (Ω·m), L is length (m) and A is cross-sectional area (m²). A long, thin piece gives higher resistance; a short, thick piece gives lower resistance. The **electrical conductivity** σ is simply the inverse of resistivity: $\sigma = 1/\rho$ (units: S/m, where S = siemens). High σ means good conductor. *Typical values:* copper ~6×10^7 S/m (at room temp), which corresponds to $\rho \approx 1.7 \times 10^{-8}$ Ω·m. A good insulator might have ρ on the order of 10^{12} Ω·m or more (virtually infinite resistance for practical purposes in FE problems).

Exam Handbook Search Cues (Not affiliated with or endorsed by NCEES): capacitance, permittivity, dielectric constant, resistivity, conductivity, parallel plate, $C = \varepsilon A/d$, $R = \rho L/A$

Footnotes:

- *Symbol conventions:* Be careful not to confuse ρ (resistivity) with ρ as used for mass density in other formulas. The context will usually make it clear: in electrical formulas ρ is resistivity, in mechanical/thermal formulas ρ is density. In the exam reference, look at the section context or units to be sure.

- *Units:* Permittivity in F/m can be a tiny number (8.85×10^{-12}), whereas resistivity can range widely. If a problem gives resistivity in, say, μΩ·cm, convert it: 1 μΩ·cm = 1×10^{-6} Ω × 1×10^{-2} m = 1×10^{-8} Ω·m. It's easy to misplace decimal points here; double-check unit conversions with scientific notation on your calculator.

- *Scope:* The FE Mechanical generally won't delve into semiconductor bandgaps or complex dielectric behavior – stick to the basics of using these formulas in straightforward ways.

Variations, Related Concepts, Typical Values:

- **Dielectrics:** Some materials have frequency-dependent permittivity (dispersion), but FE problems will likely treat κ as a constant. Typical dielectric constants: vacuum 1.0; air ~1.0006 (essentially 1); water ~80 (makes water a great capacitor dielectric, but also a conductor if impure); glass ~5; PTFE ~2; ceramic capacitors ~ up to 1000 for specialized ferroelectrics. High-κ materials allow large capacitance in small volumes – useful in capacitors.

- **Ohm's Law link:** Remember $V = IR$. If you compute R from ρL/A, you can then find voltage drop for a given current, etc. In design, resistivity explains why high-power transmission lines (low ρ) minimize losses, and why a nichrome heater (high ρ) heats up. While Ohm's law itself might appear in the electrical section, it's often combined with material properties (e.g., find the resistance of a steel wire of given dimensions and the voltage needed to achieve a certain current).

- **Temperature effects:** As a footnote, resistivity of metals increases with temperature (they get more resistive when hot), while semiconductors decrease resistivity when hot. The exam may give a temperature coefficient of resistivity in a problem; use $R = R_0[1 + \alpha(T - T_0)]$ if so. But that's more of an electrical engineering detail – mention it only if you see a reference to it.

Special Notes (Calculator Use): Calculating with very large or small numbers (ε_0, etc.) can be error-prone. When entering $C = \varepsilon A/d$, it might help to do $\varepsilon \times A$ first, then divide by d. If using the TI-36X Pro (for instance), use the scientific notation mode: enter 8.85×10^{-12} for ε_0. Also, to avoid confusion, you can calculate $Y = \kappa\varepsilon_0$ as an intermediate result if κ is given. For resistivity problems, ensure you include all parentheses: e.g., typing 1.7×10^-8 * (L / A). It's easy to miss an exponent or a parenthesis under time pressure, so practice these one-liner calculations beforehand.

Explanation & Analysis: Electrical properties connect material science to circuit behavior. On the FE, an example question might be: *"A parallel-plate capacitor is made of two* 10 cm × 10 cm *plates separated by 1 mm of Teflon (κ ≈2). Compute its capacitance."* You'd convert areas to m² (0.01 m²) and distance to m (0.001 m), compute ε = $2\times8.85\times10^{-12} = 1.77\times10^{-11}$ F/m, then $C = 1.77e - 11 * 0.01/0.001 \approx 1.77e - 10$ F (0.177 nF). The key steps are recognizing the formula and handling units.

Another scenario: *"What is the resistance of a 10-m long copper wire of 1 mm diameter?"* You'd use $R = \rho L/A$. Copper's resistivity ρ ~ 1.7×10^{-8} Ω·m; length L=10 m; area $A = \pi(0.0005m)^2 = 7.85e - 7m^2$. So $R \approx 1.7e - 8 * 10/7.85e - 7 \approx 0.216\Omega$. A common mistake would be to forget to square the radius or to use diameter in place of radius – be careful. The result should intuitively be a fraction of an ohm for a reasonably thick copper wire of that length; if you got 2×10^{-4} or 2×10^{3}, you'd know to re-check your math.

At a conceptual level, **permittivity and resistivity are intrinsic** – they don't depend on shape, while capacitance and resistance do depend on geometry. That's why the exam might ask something like: "If you double the separation between capacitor plates, what happens to capacitance?" (Answer: halves, since $C \propto 1/d$.) Or "If you stretch a wire making it twice as long and half the cross-sectional area, how does its resistance change?" (Longer and thinner → L doubles, A halves, so L/A goes up by factor 4, thus resistance 4× higher). These proportional reasoning questions are favorites – you can solve quickly by the formula without doing full calculations. Always double-check that you apply changes correctly (e.g. area scaling with diameter squared).

In summary, treat $C = \varepsilon A/d$ and $R = \rho L/A$ as straightforward tools: identify the variables, plug in carefully with consistent units, and double-check if the answer is reasonable (e.g. capacitors in picofarads to microfarads range, resistances in milliohms to ohms for typical sizes, not astronomically huge unless it's an insulator).

Quick micro-check: If a certain material has twice the dielectric constant of another, and all else (A, d) is equal, how much larger is the capacitance? (Answer: twice as large – capacitance scales linearly with κ.)

K09.T01.S03 – Mechanical Properties: Stress–Strain (Definitions, Young's Modulus E, Shear Modulus G, Poisson's Ratio ν)

Principle (Stress–Strain and Elastic Moduli):

- **Stress** and **strain** are fundamental to describing mechanical properties. **Engineering stress** is defined as force divided by the

original cross-sectional area ($\sigma = F/A_0$). **Engineering strain** is change in length over original length ($\varepsilon = \Delta L/L_0$). These "engineering" measures use the initial dimensions as reference.

- **True stress** is force divided by the *instantaneous* cross-sectional area ($\sigma_T = F/A_{\text{instant}}$), and **true strain** is the cumulative infinitesimal strain $\varepsilon_T = \ln(1+\varepsilon)$. True measures account for the actual changing dimensions as a material stretches. For small elastic deformations, engineering vs true values are nearly identical; differences matter mostly beyond yield (plastic deformation). On the FE exam, unless specifically stated, you'll usually use engineering stress–strain definitions (they're simpler).

- **Young's Modulus (E)** is the slope of the stress–strain curve in the elastic (linear) region for tensile/compressive loading. It quantifies **stiffness**: a higher E means the material resists stretching more (requires more stress to achieve the same strain). Steel, for example, has $E \approx 200$ GPa, whereas aluminum has $E \approx 70$ GPa, and rubber has $E \sim 0.01$ GPa – vastly more compliant.

- **Shear Modulus (G)** is the equivalent of E for shear loading – it's the slope of shear stress vs shear strain in the elastic region. For most materials, G is about $E/2.5$ to $E/3$ (for steel, $G \approx 77$ GPa).

- **Poisson's Ratio (ν)** relates lateral strain to axial strain under uniaxial loading. When you stretch a material, it usually gets thinner in the perpendicular directions. $\nu = -\frac{\text{lateral strain}}{\text{axial strain}}$. For example, pull a rubber band (axial tension yields positive strain), it narrows (lateral strain is negative), and ν comes out positive. Most common materials have ν between 0 and 0.5. Metals are around 0.3 (steel ~0.29, aluminum ~0.33), rubbers are near 0.5 (almost incompressible, volume constant during deformation), and some foams or exotic materials can have ν close to 0 (or even negative for special auxetic materials).
- These moduli (E, G, ν) are **elastic constants** for a material. In the linear elastic regime (small strains, no permanent deformation), they completely describe how a material deforms under stress. For isotropic materials, they are interrelated (next subtopic covers that relation). On the exam, typical uses include computing deformations (using Hooke's law), determining stresses under load, or identifying material behavior (e.g., "which material is stiffer?" from E values).

Definition Passport – Engineering vs True Measures

- **Plain-language definition:** *Engineering stress* $\sigma = F/A_0$ and *engineering strain* $\varepsilon = \Delta L/L_0$ use the original dimensions as reference. *True stress* $\sigma_T = F/A_{\text{instant}}$ and *true strain* $\varepsilon_T = \ln(L_{\text{instant}}/L_0)$ (which simplifies to $\ln(1+\varepsilon)$ in uniform elongation) use current dimensions.

- **Where it matters (exam impact):** Most exam problems assume small strains or explicitly give "stress" meaning engineering stress. True stress/strain might be mentioned conceptually (to interpret a curve beyond necking, for example), but you typically won't need to calculate true stress unless asked in theory. Know that true stress > engineering stress once material has significant plastic deformation (because $A_{\text{instant}} < A_0$ as it necks down).

- **Pitfall or confusion point:** Don't mix up the two when using formulas. For Hooke's law ($\sigma = E\varepsilon$), σ and ε must be of the same type (engineering with engineering, or true with true if in plastic range with a more complex true stress formulation). However, since Hooke's law is only valid in the initial linear region, using engineering values is fine. A common confusion: after significant plastic deformation, engineering stress can drop (when necking occurs) while true stress keeps rising (because area reduction raises actual stress). For the FE exam, focus on the elastic and yield region, unless a question specifically goes into true stress.

- **Micro-check:** If a rod doubles in length, engineering strain is 100% (ε=1). True strain is $\varepsilon T = \ln(2) \approx 0.693$. So, for large elongations, **engineering strain is larger than true strain**.

Equation Passport – Hooke's Law (Tensile)
Hooke's Law – relates normal stress and strain in the elastic regime (1D linear elasticity)

$$\sigma = E\,\varepsilon$$

Variables and Units:

- σ = normal stress (tensile or compressive), in **Pascals (Pa)** or more commonly **MPa** in engineering use. (1 MPa = 10^6 Pa; 1 psi ≈ 6895 Pa – the exam may use either SI or USCS, e.g., psi for stress.)

- E = Young's Modulus (Elastic Modulus), in Pa (N/m²). Often given in GPa or PSI (e.g., steel ~ 29,000 ksi which is 29x10³ ksi). It's a material constant indicating stiffness.

- ε = normal strain (dimensionless, typically expressed as a decimal or in % for large values). Strain = 0.001 is 0.1% elongation.

Assumptions and Scope:

- **Linear elastic behavior:** Hooke's law holds only up to the proportional limit (where the stress-strain curve is a straight line). For metals, that's roughly up to the yield point. Beyond that, the material yields or stiffens nonlinearly and Hooke's law no longer applies. The exam will usually either keep you in the elastic range or clearly indicate if plastic.

- **Uniform stress and small strain:** We assume the specimen is uniform and the deformation is small enough that A doesn't change much (so engineering stress is fine to use). We also assume one-dimensional stress state (no significant lateral stresses) – which is valid for a simple tension test or a rod in tension/compression.

- **Isotropic material:** E is the same in tension and compression and in all directions. Most metals and isotropic materials meet this. For anisotropic materials (like composites or wood), Hooke's law can still apply but E differs by direction; however, anisotropy is beyond FE scope unless qualitatively mentioned.

Limit tests (sanity checks):

- If $E \to \infty$ (an infinitely stiff material), then for any finite stress, $\varepsilon \to 0$. That matches intuition: an infinitely rigid material doesn't deform under finite load. In reality, no material has infinite E, but comparisons: ceramics have higher E than polymers – they deform less for the same stress.

- If E is very low (like rubber, ~0.01 GPa), a small stress causes a large strain. This is why a rubber band (low E) stretches a lot under even a light load, whereas a steel rod (high E) hardly stretches unless the load is huge.

- **Check units consistency**: 1 Pa = 1 N/m², so if stress is given in MPa and strain is unitless, E comes out in MPa. If you plug stress in psi, strain dimensionless, E will be in psi. The equation itself doesn't change, but be consistent within one system to avoid mixing units.

Use vs. sibling equations: Hooke's law ($\sigma = E\,\varepsilon$) is for **normal stress/strain** in tension or compression. Use it instead of the **shear formula ($\tau = G\,\gamma$)** when dealing with axial loads. Conversely, use the shear form for torsion or shear situations. Both are forms of linear elasticity; just pick the one matching the stress type. If multiple stress components exist, Hooke's law generalizes (see 3D Hooke's law in Mechanics of Materials references), but the exam often treats one component at a time unless doing combined stress analysis (in which case superposition can be used if linear).

Common exam traps:

- **Units, units, units:** It bears repeating – many calculation mistakes come from not converting MPa to Pa or forgetting that strain is unitless (e.g., 0.002, not "0.2%" directly). If using a formula like $\delta = (PL)/(AE)$ (axial deformation), make sure P is in N, L in m, A in m^2, E in Pa to get δ in m. If mixing mm and m, you'll be off by factors of 1000.

- **Yield vs elastic:** Hooke's law stops at yield. If a problem gives a stress beyond yield and asks for deformation, it's either a trick (you're supposed to stop at elastic limit) or it's implying a plastic calc (which usually is out of scope except perhaps computing permanent set by offset method). Most likely, they won't require computing plastic strain in FE; they'd just mention yield as a limit. So don't blindly apply $\sigma=E\varepsilon$ if σ is above the material's yield strength – first check that the material is still elastic.

- **Lateral strain confusion:** A common mistake is to plug lateral strain into E. Remember E links the *same direction* stress and strain. If a rod elongates and you want the lateral contraction, Hooke's law isn't directly used – instead, lateral strain = $-\nu$ * axial strain. We'll cover Poisson's effect explicitly: just keep in mind E relates σ and ε along one axis, while ν couples perpendicular directions.

- **Wrong area for stress:** Engineering stress uses original area A_0. If a problem explicitly asks for "true stress", you'd need the reduced area at that load (which is rarely given unless it's a conceptual question). So usually stick to A_0. If a bar necks and they ask something after necking, they likely are testing if you know the concept rather than making you compute an exact true stress (which would require data beyond scope).

Exam Handbook Search Cues (Not affiliated with or endorsed by NCEES): stress, strain, Hooke's law, Young's modulus, elastic modulus, Poisson's ratio (definition), engineering vs true stress

Footnotes:

- *Notation:* Sometimes the FE reference uses P or δ. For example, $\delta = \frac{PL}{AE}$ is the axial deformation formula derived from integrating Hooke's law (constant E, uniform cross-section). If you see that formula: P = force, L = length, A = cross-section, E = modulus. It's just an extension of $\sigma = E\,\varepsilon$ over a length. Recognize it in case a problem asks "how much will this rod elongate under load?"

- *Units nuance:* 1 psi = 6895 Pa, 1 ksi = 1000 psi. Many tables list E in psi or ksi for familiar materials: e.g., E (steel) ~ 30×10^6 psi (30 million psi) = 30×10^6 psi = 30×10^3 ksi = 30,000 ksi. It helps to remember a couple of baseline E values in both SI and USCS for sanity checks: **Steel ~ 200 GPa ~ 29,000 ksi**; **Aluminum ~ 70 GPa ~ 10,000 ksi**. If an answer choice for steel's E was "2900 ksi" you'd flag it as off by a factor of 10.

- *Scope:* Know the definitions (stress, strain, moduli, Poisson's) and their basic relationships. You *won't* need to derive stress–strain curves or solve complex true stress problems on the FE – those are more for a mechanics of materials course depth. Focus on using the properties: computing one when given the others, identifying units, and conceptual effects (like what a higher E implies).

- *Why students slip:* Rushing, some confuse yield strength (a stress at which permanent deformation begins) with Young's modulus (a slope). Remember: **yield strength** might be ~250 MPa for a mild steel, whereas **E = 200,000 MPa**. They are different beasts – one is a stress level, the other is a ratio. If a question mentions one, don't use it for the other by mistake.

Variations and Related Forms:

- **Shear stress–strain:** The analogous Hooke's law in shear is $\tau = G\,\gamma$. It's exactly the same form: shear modulus G relates shear stress τ (units Pa or psi) to shear strain γ (dimensionless, radians for small angles). We typically cover that in the next subtopic along with the E–G–ν relation, but keep in mind the concept: materials also elastically deform in shear, and G quantifies that stiffness.

- **Elastic energy:** You might recall $U = \frac{1}{2}\sigma\varepsilon V$ or $U = \frac{1}{2}E\varepsilon^2 V$ for strain energy in a volume, or $\frac{1}{2}kx^2$ for a spring (where $k = AE/L$ for a rod). While it's possible an exam question touches on stored energy (less common in Mechanical FE than in civil), knowing that a higher modulus means more energy stored for the same strain is useful. But if time is short, prioritize direct stress-strain relations over energy formulas.

- **Typical values:** Already mentioned but to summarize:

Metals – E ~ 45 GPa (magnesium) to 210 GPa (steel, at the high end for iron alloys), ν ~0.25–0.35. **Ceramics** – E often high (200–400 GPa for some carbides, alumina ~300 GPa), but brittle (no yield point, they fracture at low strains). ν for ceramics ~0.2 or less.

Polymers – E is very low (0.001 to a few GPa), ν ~0.4–0.5 (rubbery materials nearly incompressible volumetrically).

Composites – can vary widely; carbon fiber in one direction has super high E (≈150–250 GPa along fiber) but low transverse. These details are more for context; exam will likely stick to common isotropic materials.

Special Notes (Calculator): Solving $\sigma = E\varepsilon$ is straightforward algebra, but be cautious with scientific notation if, say, solving for ε: $\varepsilon = \sigma/E$. If σ = 50 MPa and E = 200 GPa, then $\varepsilon = 50\times10^6 / 200\times10^9 = 0.25\times10^{-3} = 2.5\times10^{-4}$ (0.025%). It's easy to misplace the decimal on such small strains. Use your calculator's exponential format: input 50×10^6 ÷ 200×10^9 (with parentheses if needed: $(50\times10^6)/(200\times10^9)$). The result should be 2.5×10^{-4}. Many exam mistakes come from either neglecting the 10^9 or mis-keying it, so practice a couple to get the hang of it. Also, if doing axial deformation: $\delta = PL/(AE)$, do it stepwise if needed (P/A first to get stress, then divide by E to get strain, then times L to get δ). Breaking it up can reduce error.

Explanation & Analysis: In practical terms, **Young's modulus E** tells you how much a material will stretch/compress under a given stress. If two rods (one steel, one aluminum) have the same dimensions and load, the aluminum rod will deform about 3 times more than the steel rod because aluminum's E is ~1/3 of steel's. The FE exam may give you a problem where you compute an axial deformation or a required diameter given a deformation limit. You'd use Hooke's law in the form $\delta = \frac{PL}{AE}$: rearrange to find A or whatever is needed. That formula comes from integrating $\sigma=E\varepsilon$

over length (assuming uniform stress/strain). If not memorized, you can derive it quickly: stress σ = P/A, strain ε = δ/L, and σ = E ε, combine to δ = (σ/E)L = *(P/A)*(L/E) → $PL/(AE)$. Recognize it in case the handbook reference shows it directly.

Poisson's ratio ν: If a question says a steel rod elongates by 1 mm under tension, and asks how much it narrows in diameter, that's where ν comes in. $\varepsilon_{\text{lat}} = -\nu\varepsilon_{\text{axial}}$. So if ν=0.3 and axial strain = 0.001 (0.1%), lateral strain = -0.0003, meaning a 0.03% decrease in diameter. With a 10 mm original diameter, that's a change of 0.003 mm – tiny. Often the exam won't go into such minor detail unless testing understanding of concept (like "does it get thinner or thicker when pulled?" – answer: thinner for normal materials). However, if it's in the handbook, it's fair game to use: so remember the negative sign (lateral strain is opposite in sign to axial for conventional materials; materials don't expand laterally when stretched axially, they contract).

Engineering stress–strain curve basics: While not explicitly asked for in the outline, it's worth recalling: the curve starts linear (slope E), then yields (flat or drop for metals like mild steel), then strain hardens (stress rises again), reaching ultimate tensile strength (max stress), then necks and true stress continues rising but engineering stress drops to fracture. Key points: **Yield strength** (point of permanent deformation), **UTS** (maximum engineering stress), **fracture point**. If the exam gives a stress-strain graph, you might be asked to identify these points or calculate approximate modulus from the slope. If given data, computing E = σ/ε from the initial linear portion is straightforward (just pick a stress-strain pair in linear region).

Finally, consider what happens under **compression**: Same E and ν apply, but the material will bulge laterally (Poisson's ratio still dictates lateral expansion now). Many materials have similar tension/compression behavior in the elastic range (until things like buckling or crushing come into play, which are separate phenomena).

In summary, mastering these definitions means you can confidently handle any question that asks for strain under load, stress under deformation, or material comparisons by stiffness or ductility. If a question gives you two materials and says one has a higher E and asks what that means: answer is it's stiffer (less strain for same stress). If it asks which will store more elastic energy under the same stress, you could reason via $U = \frac{1}{2}\sigma^2 V/E$ (not likely needed) or just conceptually: the one with lower E will deform more and thus area under curve (energy) might differ – but such nuance is probably beyond FE scope. Stick to core understanding: high E = stiff, high yield = strong (resists permanent deformation), high toughness = area under curve (that comes later, fracture toughness concept).

Quick micro-check: A 1-m long steel rod and a 1-m long aluminum rod, each 1 cm² in cross-section, are stretched by a 10 kN force. Which one elongates more? (Answer: Aluminum, because E is lower, so ε = σ/E is higher; roughly 3x more elongation than steel for the same stress.)

K09.T01.S04 – Shear Stress–Strain and Elastic Constants (Relations Between E, G, and ν)

Principle (Shear Modulus and Elastic Constant Relationships):

- Materials deform in shear as well as in tension. The **shear stress–strain relationship** for small deformations is analogous to Hooke's law: **τ = G γ**, where τ is shear stress and γ (gamma) is shear strain (a small angle in radians). **Shear modulus G** (also called modulus of rigidity) describes material stiffness in shear. For example, to twist a shaft, the resistance is proportional to G.

- **Elastic constants linkage:** For isotropic materials (same properties in all directions), the elastic constants E, G, and ν are not independent – they are related by:

$$G = \frac{E}{2(1+\nu)}.$$

This formula allows you to calculate one if you know the other two. It shows, for instance, that if a material could have ν = 0.5 (theoretical upper limit for incompressibility), then $G = E/3$. For most metals ν ~0.3, so $G \approx E/2.6$.

- Another elastic constant not in the subtopic title but often present is the **Bulk Modulus K**, relating to volumetric change under hydrostatic pressure. The relation there is $K = \frac{E}{3(1-2\nu)}$. While K might be in the reference, it's more relevant to civil (soil, concrete) or general material science. For mechanical exam purposes, E, G, ν are the main trio, but remember K exists (if an exam question touches on compressibility of a material under pressure, K would be involved). Usually, you won't need to compute K unless explicitly asked, but just note the form of the formula and that ν = 0.5 would blow K up to infinity (truly incompressible material).

- **Practical insight:** The E–G–ν relationship means not all combinations are possible. If you pick an E and ν, G is fixed. For instance, if someone tells you "this new alloy has E = 210 GPa and G = 80 GPa," you can check ν = (E/(2G)) - 1 = 210/(2*80) - 1 = 1.3125 - 1 = 0.3125, which is plausible. If they claimed G = 50 GPa with E = 210 GPa, ν would be 1.1 (impossible, since ν > 0.5 is unphysical for stable materials). So one use of the relation is to sanity-check data. On the exam, you might need to compute G given E and ν (common) or find ν given E and G.

Equation Passport – Elastic Moduli Relationship
Connects Young's Modulus (E), Shear Modulus (G), and Poisson's Ratio (ν) for isotropic materials

$$G = \frac{E}{2\,(1+\nu)}$$

Variables and Units:

- G = shear modulus, in **Pascals (Pa)** (often reported in GPa or ksi, similar scale to E but typically smaller in value).
- E = Young's (elastic) modulus, in Pa.
- ν = Poisson's ratio, **dimensionless** (no units). It's typically between 0 and 0.5 for common materials (0.3 is a handy ballpark for metals).

Assumptions and Scope:

- Material is **homogeneous and isotropic.** The formula is derived from generalized Hooke's law for isotropic materials. If a material is anisotropic (like wood, composites), it has different moduli in different directions and a single ν isn't enough – those cases are beyond FE scope unless qualitatively stated.

- **Linear elastic range:** These relationships assume linear elasticity (valid before yield/fracture). If a material is behaving nonlinearly or has damage, these simple linear relations don't hold. FE problems stick to linear realm when using these constants.

- Applies to **small deformations** (as all these linear relations do). No volume change assumptions beyond those inherent in ν's meaning (ν relates lateral vs axial strain at small strain).

Limit checks:

- If $\nu = 0$ (no lateral contraction – a hypothetical material that doesn't shrink or expand sideways when stretched), then $G = E/2$. So shear modulus is half of Young's modulus in that case. Materials with very low ν (like cork ~0, which is why cork seals don't expand laterally when compressed) have $G \approx E/2$.

- If $\nu \to 0.5$ (material tends toward incompressible, like rubber ~0.49), then denominator $2(1+\nu) \to 2(1.5) = 3$. So $G \approx E/3$. Indeed rubbers have G roughly a third of E. As ν gets closer to 0.5, materials become very "squishy" in shear relative to tension (since volume can't change, shape change occurs more readily under shear).

- If someone tries an extreme: $\nu = -1$ (which would mean material expands laterally when stretched – some exotic engineered materials can have negative Poisson's for small ranges), plug in and you get $G = E/\big(2(1-1)\big) = E/0$ infinite, which doesn't make sense physically; negative ν materials are still bound by deeper conditions and typically small magnitude. For normal exam purposes, assume $0 \le \nu \le 0.5$.

- **Units consistency:** E and G must be in the same units to use the formula. If E is in GPa, G comes out in GPa. If E in psi, G in psi. Just be mindful not to mix unit systems.

Use vs. sibling equations: Use this formula whenever you need to find G from known E and ν (or vice versa). It's more direct and reliable than trying to derive from first principles under time pressure. If the exam gives you a shear problem but only provides E and ν, you *must* use this to get G first. Do not confuse this with the relation involving **bulk modulus K** (that one has $1 - 2\nu$ in denominator). If you see a volumetric strain or hydrostatic scenario, then bring in K = E/[3(1-2ν)]; for a shear or torsion scenario, use G = E/[2(1+ν)].

Common exam traps:

- **Forgetting to add 1 in the denominator:** It's 2(1+ν) not 2ν. The derivation comes from geometry of strain in two perpendicular directions. A mistake some make is writing $G = E/2\nu$ (which would dimensionally be nonsense because ν is dimensionless). So memorize it with a simple case: ν=0 gives G = E/2; that helps you remember the "+1" inside.

- **Solving for ν algebraically:** if asked for Poisson's ratio given E and G, rearrange $G = E/[2(1+\nu)]$ to $1 + \nu = E/(2G)$, so $\nu = E/(2G) - 1$. A common arithmetic mistake is solving that wrong. For example, if E/(2G) = 2.5, then ν = 1.5 (which is impossible). Always sanity-check ν is between 0 and 0.5 for normal materials. If you get something outside, you likely mis-plugged numbers.

- **Mixing up G and E roles:** In beam deflection or shaft twist formulas, ensure you use the correct modulus: bending and axial deformation use E, torsion uses G. If a question gives you both E and G for some reason, they might be expecting you to use one in one part and the other in another part. Some examinees mistakenly use E where G is needed. A quick clue: if it's about **angles (twist, shear angles)** → likely G; if it's about **length changes** → E.

- **Units (again!):** If E is given in, say, Mpsi (millions of psi) and G in GPa, convert one to the other system before using the formula. 30 Mpsi for E and 11,000 ksi for G – better to convert both to psi (E=30,000 ksi, G=11,000 ksi) then ν = 30000/(211000) - 1 = ~0.364. That's a plausible ν for some steel (they vary 0.27–0.30 typically, so 0.364 would actually be on high side; maybe my example numbers aren't realistic pair – indeed steel's actual G if E=30,000 ksi and ν=0.3 would be 30,000/(21.3) ~ 11,538 ksi. So 11,000 ksi G corresponds to ν ~0.36 which is a bit high for steel but not impossible for some alloys). The point is: do the algebra carefully with units aligned.

Exam Handbook Search Cues (Not affiliated with or endorsed by NCEES): shear modulus, τ = Gγ, modulus relations, E = 2G(1+ν), Poisson's ratio, bulk modulus (if needed)

Footnotes:

- *Torsion formula:* While not exactly this subtopic, if you have a circular shaft in torsion, angle of twist φ = (T L)/(J G). That's a formula using G. If you don't have G directly, you'd compute it from E and ν. Keep that connection in mind: the exam might require a multi-step solution where the first step is getting G via this relationship, then plugging into a torsion or shear deformation formula.

- *Material incompressibility:* As ν → 0.5, note bulk modulus $K = E/[3(1-2\nu)]$ blows up, meaning the material resists volume change greatly. Meanwhile, $G = E/[2(1+\nu)]$ is still finite. This indicates a rubber (high ν) is easy to shear (low G, since E is low too) but hard to compress (requires a lot of pressure to change volume). This concept might appear qualitatively. For instance, a question could ask "Why do incompressible materials have Poisson's ratios close to 0.5?" or "If a material has ν = 0.49, what behavior does that indicate?" – expected answer: it nearly preserves volume when deformed; it's rubber-like.

- *Scope:* You usually won't need to derive these formulas; just use them. But it's good to understand origin: the relationship comes from combining Hooke's law in 3D and solving for shear response with lateral contraction accounted for. The exam won't ask you to derive it, just to apply it.

Variations and Related Forms:

- **Bulk modulus K relation:** $K = \frac{E}{3(1-2\nu)}$. If needed, use it similarly (rearrange to find ν given K/E or vice versa). While this subtopic is about E, G, ν, be aware K might lurk in a handbook table. For example, they might list a material with E and K, and you could be asked to find ν. Using both formulas, you could solve: from K relation $1 - 2\nu = E/(3K)$, etc. But again, this is less likely unless the exam is tying into a fluids or thermal (volumetric expansion) concept.

- **Alternate form of E–G–ν:** You might see it solved for E: $E = 2G(1+\nu)$. This is the same formula rearranged. Sometimes giving it in this form emphasizes: to increase E for a given G, you need higher ν (which can only go so high). Materials like rubber (high ν ~0.5, low E) vs steel (moderate ν, high E) illustrate that differences in E are mostly due to atomic bond stiffness (affecting both E and G) rather than ν. But for exam, just use whichever form directly plugs in your known values easiest.

- **Typical values:** We've mentioned typical E and G. A typical ν for steels ~0.27–0.30, aluminums ~0.33, concrete ~0.2, wood ~0.3 (along grain can be weird because anisotropic though). Many polymers ~0.35-0.45, rubber ~0.5 (virtually). If a problem gives a ν

outside 0-0.5, question it – either data error or a trick about stability (materials with ν ≥ 0.5 would violate assumptions). Some cork or foam can have ν ~0 (cork), or negative (~-0.1 for certain auxetic foams) but I doubt FE goes into negative ν. So likely ν in 0 to 0.5 exclusively.

Special Notes (Calculator): The formula is simple, but watch out for parentheses when plugging in: On a Casio or TI, it's safest to do $\frac{E}{2(1+\nu)}$. For example, if $E = 10 \times 10^6$ psiand $\nu = 0.25$, do $10 \times 10^6/(2(1+0.25)) = 10 \times 10^6/(2 \cdot 1.25) = 10 \times 10^6/2.5 = 4 \times 10^6$ psi (which is G). If you forget parentheses and do $10 \times 10^6/2(1+0.25)$, most calculators will do $10 \times 10^6/2 = 5 \times 10^6$, then $\times 1.25 = 6.25 \times 10^6$, which is wrong by a factor 1.5625. So be mindful of order of operations or just calculate step by step: first compute denominator $= 2(1+\nu)$, then Edivided by that. It's quick and avoids a mistake.

Explanation & Analysis: Suppose an exam question says: *"A material has E = 70 GPa and ν = 0.33. What is the shear modulus?"* You'd plug into $G = E/[2(1+0.33)] = 70/[2 * 1.33]GPa \approx 26.3GPa$. You might see answer options around 26 GPa (correct), and maybe some traps: 35 GPa (if someone mistakenly did E/2), or 47 GPa (if someone did E/(2(1-ν)) incorrectly using the wrong formula). By knowing the expected range – G should be less than E – you can eliminate obviously wrong answers.

Another angle: if given G and E, and asked for ν, do $\nu = E/(2G) - 1$. For example, E=210 GPa, G=81 GPa, $\nu = 210/(162) - 1 = 1.296 - 1 = 0.296$ (~0.30). They might frame it as: "Steel has E ~ 200 GPa and G ~ 80 GPa. Estimate its Poisson's ratio." This tests recognition of the formula and typical values (and indeed ~0.3 is a known Poisson's ratio for steel).

Why is this important? Some exam problems might not explicitly give all three constants, expecting you to calculate one. For instance, a **torsion** problem might give shear strain and ask for stress, providing E and ν in the problem statement (so you have to first find G). Or a **deflection** problem might give a hint like "material's Poisson ratio is…" which is your clue that maybe you should compute something like lateral strain or use it to get the right modulus.

Shear stress–strain behavior: If you take a block of material and apply a shear force, causing a small angular deformation γ (in radians), τ = Gγ tells you how much stress (force/area) is needed for that shear angle. A high G material (like steel) will barely deform for a given shear stress; a low G material (rubber) will deform a lot. In lab terms, if you have a torsion test on a rod, you measure angle of twist per length and torque per angle to find G (similar to how you measure E via tensile tests).

Poisson's ratio effects: The E–G–ν link implicitly includes that when you shear a material, there's also some associated slight volume change or shape coupling – but that's deep theory. For exam purposes, using the formula correctly is enough. If they give an under-constrained problem like "a rod is subjected to both tension and torsion" with mixed data, handle each stress component separately (using appropriate modulus for each) – combined deformation would require superposition, but that's rarely needed beyond perhaps a conceptual check that one mode dominates.

In conclusion, **remember the relationship** $G = \frac{E}{2(1+\nu)}$ as a staple of materials mechanics. It saves time and prevents you from solving simultaneous equations on the fly. It's provided in the reference, but you should be comfortable applying it quickly. It also reinforces understanding: materials with a higher Poisson's ratio have a lower G for a given E, meaning they are a bit more compliant in shear relative to tension. Materials with ν near 0 (cork) have G ~ E/2, relatively stiff in shear compared to tension.

Quick micro-check: A certain plastic has $E = 3$ GPa and $G = 1$ GPa. What's its Poisson's ratio? *(Compute:* $\nu = E/(2G) - 1 = 3/(2*1) - 1 = 3/2 - 1 = 0.5$. *So it's right at the upper realistic limit – likely a rubbery plastic nearing incompressible behavior.)*

K09.T01.S05 – Fracture Toughness (K_IC) and Material Resistance to Crack Propagation

Principle (Fracture Toughness):

- **Fracture Toughness**, usually written K_{IC} (the mode-I critical stress intensity factor), is a material property that describes how well a material resists brittle crack growth when a crack is present. In simpler terms, it tells you how well a material can withstand a crack or flaw before it fractures catastrophically. A higher K_{IC} means the material can tolerate a larger flaw or higher stress without breaking.

- Fracture toughness is expressed in units of stress * sqrt(length), e.g. **MPa·√m** (or in US units, ksi·√in). It comes from Linear Elastic Fracture Mechanics (LEFM), where the stress intensity factor K characterizes the crack-tip stress field. At the critical value $K = K_{IC}$, the crack will start rapidly growing and cause failure.

- The fundamental LEFM formula for mode-I (opening mode) crack is:

$$K_I = Y\sigma\sqrt{\pi a},$$

where a is the crack length (for through cracks in infinite plates, a is half crack length if a crack goes all the way through both sides, or the actual crack length if edge crack), σ is the applied stress (far-field tensile stress), and Y is a dimensionless geometry factor (depends on crack shape and component geometry, usually of order ~1). **Don't worry**, you don't need to derive this on the FE, but you might use it to solve for one variable if given the others.
- When K_I reaches K_{IC} for the material, fracture occurs. Engineers use K_{IC} to determine safe crack sizes or allowable stress: e.g., solve $\sigma_{\text{allowable}} = \frac{K_{IC}}{Y\sqrt{\pi a_{\max}}}$ to avoid fracture. If a material has a low K_{IC}, even a small crack can be dangerous; high K_{IC} materials can tolerate larger cracks.

- **Typical values:** Metals have relatively high fracture toughness (they can undergo some plastic deformation at the crack tip which blunts it). Ceramics and glass have very low K_{IC} (they fracture suddenly with minimal plasticity). For instance, a high-toughness steel might have $K_{IC} \sim 50$ MPa·√m, aluminum alloys around 20–40 MPa·√m, while a ceramic like alumina might be ~4 MPa·√m. These differences align with what we know: you can scratch glass and it shatters easily (low toughness), but you can put a notch in a steel bar and it still takes considerable force to break (higher toughness).

- It's important not to confuse **fracture toughness (K_IC)** with **strength**. Strength (like tensile strength) is stress at failure for a flaw-free specimen of a given size. Fracture toughness specifically quantifies flaw tolerance. A high-strength material can actually have low toughness (example: glass fiber – very high strength when flaw-free, but a tiny nick causes failure, so low toughness). For FE questions, if they mention K_{IC}, they are in context of crack or flaw problems.

Equation Passport – Critical Stress Intensity (Fracture Criterion)

Relates crack size, stress, and fracture toughness for mode-I loading

$$K_I = Y\,\sigma\sqrt{\pi\,a}$$

(At failure, $K_I = K_{IC}$, the critical value.)

Variables and Units:

- K_I = Mode-I stress intensity factor (in MPa$\sqrt{\text{m}}$ or ksi$\sqrt{\text{in}}$). It represents the amplified stress near a crack tip. K_{IC} is the critical value at fracture (a material property, typically measured by standard tests).

- Y = geometry factor (dimensionless). Accounts for crack shape and component boundaries. Common cases: $Y = 1$ for an internal crack of length $2a$ in an infinite plate (or a through-thickness center crack), $Y \approx 1.1$ for a surface (edge) crack of length a (since one side is free surface, somewhat higher intensity), other geometries have charts or formulas. In many exam problems, they'll simplify and give Y or assume $Y = 1$ for a "through crack in a large plate" unless otherwise specified.

- σ = applied tensile stress (Pa or psi). This is the nominal stress far from the crack (e.g., load divided by cross-sectional area, as if no crack).

- a = crack length (m or in). Careful: if it's a through crack across the whole width, sometimes $2a$ is given as the total crack length (with each tip counting as "a"). Check problem description: *"a through crack of length 10 mm"* likely means 10 mm from tip to tip across the piece – implying each half is a=5 mm if using formulas from some references. However, many textbooks define a as half-length for center cracks, so $2a$ is total length. For an edge crack, a is just the depth from the edge. The FE handbook often clarifies via diagrams. When in doubt, follow the reference's convention or the problem's wording closely.

Assumptions and Scope:

- **Linear elastic material:** The formula and K_{IC} assume linear elasticity and a brittle or semi-brittle fracture mode (little yielding at crack tip). If significant plasticity occurs, other parameters like J-integral or CTOD come into play, but those are beyond FE scope. However, many ductile metals can be approximated as having a K_{IC} for design against fast fracture (just remember: if a material yields before K_{IC} is reached, it may never experience a brittle fracture – it'll undergo stable tearing or plastic collapse instead). The FE exam won't go that deep; it treats K_{IC} in a straightforward way.

- **Mode I (tensile opening mode):** K_{IC} specifically refers to crack opening by tensile stress perpendicular to crack. There are Mode II (shear sliding) and Mode III (tearing) with K_{II}, K_{III}, etc., but those are usually not in the exam unless mentioned. Most references focus on Mode I as it's the most common catastrophic case.

- **Valid crack size range:** LEFM requires cracks not be too small relative to plastic zone; in practice there are size requirements for K_{IC} tests (to ensure predominantly linear elastic). But exam won't expect you to assess that – if they give a crack and ask, assume it's a situation where LEFM is valid.

Limit tests:

- If crack length $a \to 0$, $K_I \to 0$. A vanishingly small crack poses no danger – logically, if a piece is nearly flawless, it behaves like a continuum without stress concentration (at least until micro-cracks at some scale). This matches: no crack, no fracture driving force.

- If stress $\sigma \to 0$, $K_I \to 0$. No load, no crack propagation – obvious.

- The "critical" combination is when $K_I = K_{IC}$. Solve for any one variable: e.g., critical crack size $a_c = \frac{1}{\pi}\left(\frac{K_{IC}}{Y\sigma}\right)^2$. That result tells you the threshold crack length for a given stress. If a is larger than that, fracture is expected. Engineers might use a safety factor or crack growth analysis, but that's beyond quick calcs.
- Also, note dimensions: if you accidentally omit the sqrt, you might think $K \sim \sigma a$ which would give wrong units (Pa·m, not Pa·√m). The sqrt makes the units work: stress * sqrt(length).

Use vs. sibling concepts: Use this formula or concept instead of a simple stress = P/A when a crack is explicitly involved and fracture is of concern. If the problem is a straightforward yielding (no crack), then you'd use yield strength to assess failure, not K_{IC}. Conversely, if given K_{IC}, you're in a fracture mechanics context – likely a brittle fracture scenario or safety check. So use K formula rather than, say, Mohr's circle or yield criteria. A relevant sibling concept is **toughness (energy)** measured by area under stress-strain curve (in J/m³) – that's different (though related qualitatively; tougher materials often have higher K_{IC}). Don't confuse K_{IC} with *plane strain fracture toughness* (which it is) vs plane stress (which might use K_C for thin specimens – but FE won't split hairs; assume plane strain K_{IC} for thick sections unless told otherwise).

Common exam traps:

- **Distinguishing units:** A common oversight is to mix up MPa√m with MPa. If a question provides K_{IC} = 30 MPa·√m and a critical flaw size, and asks "at what stress will fracture occur?", ensure your algebra respects units. For example, solving $\sigma = K_{IC}/\left(Y\sqrt{\pi a}\right)$: if a is in meters, K in MPa√m, the σ you get is in MPa (good). If you put a in mm (0.005 m vs 5 mm confusion) or forget to adjust units, you'll get σ in different units. It's easy to do: say $a = 5$ mm, $\sqrt{\pi a} = \sqrt{3.1416 * 0.005} = \sqrt{0.0157} = 0.1253\sqrt{\text{m}}$. Then $\sigma = 30/(1 * 0.1253) = 239.4$ MPa. If someone accidentally used a =5 (assuming mm without converting), $\sqrt{\pi * 5}$ (with 5 in m which is wrong) = $\sqrt{15.7} \approx 3.96$, then σ = 30/3.96 = 7.57 MPa, which is off by a factor of ~32! So always convert crack length to meters (or inches if using ksi√in) to match K units.

- **Edge vs through crack:** If an edge crack of length a is given but the formula used assumes a through crack of length 2a, you need the right Y. Many tables: for center crack of total length 2a in infinite plate, Y=1, and they use a (half-length) in formula, effectively same structure. For an edge crack of length a in semi-infinite plate, Y ~ 1.12 for small a relative to width. The FE Reference likely provides a specific case or tells you Y. If not, assume Y=1 unless geometry clearly indicates edge – they might then say "use Y=1.1" or similar. Not accounting for Y properly is a trap.

- **Material identification:** They may give multiple materials and their K_{IC} values and ask something like "which material will fail first for a given flaw and stress?" Don't just look at K; consider both K and basic strength. But if the scenario is brittle fracture, the one with lowest K_{IC} usually is most critical (provided stress and flaw size are same). Alternatively, they could give fracture toughness and flaw size, and ask which needs lower stress to break

– you plug each into $\sigma = K_{IC}/\left(Y\sqrt{(\pi a)}\right)$, the lowest σ means easiest to break (least resistant). It's straightforward but easy to mis-rank if one doesn't square-root properly or convert units consistently for each.
- **K vs K^2 proportionality:** Notice a is under a sqrt. If you double crack length, K increases by √2 (about 1.414×). So fracture stress drops by 1/√2 (about 0.707×). People sometimes linearly think double crack = double K = half stress – that's not correct, it's a sqrt relationship. Keep that in mind when doing qualitative reasoning: a much larger crack drastically lowers the needed stress, but not linear. E.g., to drop critical stress by half, you need four times the crack area (since √4 =2).

Exam Handbook Search Cues (Not affiliated with or endorsed by NCEES): fracture toughness, K_{IC}, stress intensity, crack, Griffith (though Griffith's formula is an energy-based one, it might not appear in detail)

Footnotes:

- *Brittle vs ductile failure:* Typically, the FE exam might frame a conceptual question: "Material A has higher yield strength but lower fracture toughness than Material B. Under what conditions would Material A fail before Material B?" The answer: if there's a crack or flaw present and loading is such that fracture is the mode of failure (low temperature, high strain rate, or just a large flaw), material A might fracture even though it's stronger in a flaw-free test. This ties into *ductile-to-brittle transition* as well (for some steels at low temp). While you likely won't need specifics, qualitatively know that high strength alone isn't everything; toughness matters for safety margins with cracks.

- *Plane strain condition:* K_{IC} is defined under plane strain (thick sample, triaxial constraint at crack tip) which yields the minimum toughness. In thinner samples, you get a higher apparent toughness (plane stress) because material can yield more at the crack tip. FE might not mention this nuance, but just remember K_{IC} is the conservative value. If ever given both K_C and K_{IC}, K_{IC} is the lower and the one used for design (plane strain).

- *Fatigue vs fracture:* Don't mix up fracture toughness (single event fracture) with fatigue crack growth (repeated cyclic loads causing crack to grow gradually). The exam may separately have a concept question on fatigue (like S-N curves or endurance limit) – that's different. However, they are related in practice: a fatigue crack grows until it's long enough that K_{IC} is reached at the peak load, causing final fracture. But you would treat fatigue via different methods (Paris law etc, likely beyond FE Mechanical depth except maybe high-cycle endurance limit concept). So focus: K_{IC} is about *critical instantaneous failure due to a crack*.

Variations, Related Concepts, Typical Values:

- **Impact energy (Charpy V-notch):** In practice, materials are often rated by impact energy (in J, from a swinging hammer test). A high Charpy impact energy generally indicates high fracture toughness, and a ductile behavior. The exam might present a table of impact energies at various temperatures for a steel (DBTT curve concept). If so, remember that at low temps some steels become brittle (low impact energy, hence effectively low K_{IC}). If a question asks why a material that's ductile at room temp failed in brittle manner in cold, it's due to this ductile-brittle transition (tie it conceptually to reduced fracture toughness at low temp).

- **Plastic zone correction:** For high toughness ductile materials, the simple LEFM might not perfectly apply because a plastic zone forms at the crack tip. There is a concept of K_{IC} being valid only if sample is thick enough and crack size large enough relative to plastic zone. But FE likely won't go into that. Just be aware: extremely ductile materials might not have a clear K_{IC} – they yield before fracturing. The exam typically sticks to materials where K_{IC} is a meaningful number (steels, aluminums, ceramics).

- **Numerical example typical values:** To get a feel: Glass K_{IC} 1 MPa√m (very low, explains why a tiny scratch causes failure). Aluminum alloys: 20-40 MPa√m. Steels: 30-100 MPa√m depending on alloy and treatment (tempered martensitic steels can be quite tough). Titanium alloys: around 50 MPa√m. Ceramics: 2-5. Composites: fiber composites are tricky – along fibers can be high toughness if fibers bridge cracks; cross-fiber they can be low. But anyway, if you see numbers in a question, you'll at least recognize what ballpark is metal vs ceramic.

- **Safety factor design:** Engineers often specify a maximum flaw size that NDT (non-destructive testing) must detect to ensure it's below critical size for given stress. Or conversely, given a detectable crack length, they limit stress. This concept could be tested by asking you to calculate one of those. We already basically covered how to solve for a_c or σ. Just ensure to square properly and handle Y.

Special Notes (Calculator): If solving $\sigma = \frac{K_{IC}}{Y\sqrt{\pi a}}$, you might do it in steps. For example, $K_{IC} = 30$ MPa√m, $a = 0.005$ m, $Y = 1$. Compute inside sqrt: $\pi a = 3.1416 * 0.005 = 0.015708$. sqrt that: use the √ or ^0.5 on calculator: √0.015708 ≈ 0.1252 (no units, since we took sqrt of m, effectively units are √m in denominator which will cancel the √m in numerator's MPa√m leaving MPa). Then 30 / 0.1252 = 239.5 MPa. Doing it all in one sequence is possible: e.g., on TI-36X do 30 / (1 * sqrt(pi * 0.005)). Make sure the whole denominator is in parentheses. If your calculator has an "Ans" function, doing it stepwise (calc sqrt first, then K divided by that) might be safer. If solving for a, say given σ and K_{IC}, you'd be rearranging: $a = \frac{1}{\pi}\left(K_{IC}/(Y\sigma)\right)^2$. Be careful to square the entire fraction. It might be easier to compute $K_{IC}/(Y\sigma)$ first, then square, then divide by π. With big or small numbers, watch out for scientific notation (the squaring can make tiny things even tinier).

Explanation & Analysis: Let's apply these ideas in an example: *"A flat plate of aluminum alloy (K_IC = 25 MPa√m) has a through crack of length 10 mm. What is the maximum stress it can withstand without fracturing, assuming Y=1?"* Here a would be half-length if 10 mm is the total length of a crack across the plate (depending on convention). If not specified, I might assume $a = 0.005m$ (half-length 5 mm each side if it's a center crack, or if they intended edge crack of 10 mm, then a=0.01 m for that formula but Y might differ slightly). Let's assume through center crack total 10 mm, so each half-crack a=5 mm. Then, using Y=1: $\sigma_c = 25/\sqrt{\pi * 0.005}$ MPa. $\sqrt{\pi * 0.005} = 0.1253$. So $\sigma_c \approx 25/0.1253 = 199.5$ MPa. If the problem gave answer ~200 MPa, that's probably correct interpretation. If we had taken a = 0.01 m, and Y=1 (which actually would under-estimate Y a bit for an edge crack), $\sigma = 25/\sqrt{0.0314} = 25/0.177 = 141MPa$. That's quite different. The problem context (center vs edge) should be clarified by wording or figure. So **read carefully**.

Now, imagine the exam asks: *"Which material is more* fracture-tough*: a high-strength ceramic with K_IC = 5 MPa√m or a lower-strength aluminum with K_IC = 30 MPa√m?"* The answer is the aluminum – because it's got higher fracture toughness number, meaning it resists crack propagation better (even though the ceramic might handle higher stress if flaw-free, it cannot tolerate flaws). This could be a conceptual question tying together strength

vs toughness. Always pick the material with higher K_IC for crack-critical applications (pressure vessels, aircraft skins, etc., where cracks can form). Conversely, if asked something like "why do aircraft use aluminum or composites and not high-strength ceramics for skin?" – one reason is ceramics have low fracture toughness (they'd shatter with a crack) despite high hardness/strength.

Also, you might be asked to identify K_{IC} on a provided graph: sometimes a figure shows stress vs crack size at failure, and the line might correspond to K_{IC}. But that's less likely. More straightforward: plug and chug or conceptual compare.

Finally, connect to design: If a steel has a certain K_IC, engineers ensure either that operating stresses are low enough for expected flaw sizes or use NDT to catch flaws before they grow. The exam might not directly quiz that process, but understanding it helps reason through multiple-choice logic questions. For example: *"To increase the fracture toughness of a steel, one could (a) heat treat to increase yield strength, (b) temper it to reduce hardness, (c) cool it quickly to form martensite, (d) make grain size smaller."* The best answer: make grain size smaller (d) – because fine grains impede crack propagation, raising toughness. Increasing yield strength often lowers toughness (strong but brittle), tempering (softening) can improve toughness by trading off some strength, quenching to martensite can make it very strong but typically brittle unless tempered. Such materials reasoning could be tested qualitatively.

In summary, treat K_{IC} problems as an extension of stress analysis focusing on flaws. Identify if the problem is giving you K and asking for stress or vice versa. Use the formula with correct geometry factor. And remember typical magnitude differences: if you get a required stress that's astronomically high (like 10,000 MPa) or ridiculously low, double-check the crack length units or Y value. The numbers should make sense: usually allowable stresses will be in the same ballpark as material yield or UTS (tens to hundreds of MPa for metals) when a moderate crack is present. If you calculate something like 5 MPa allowable for a steel with a tiny crack, you likely mis-plugged (or the crack wasn't tiny after all).

Quick micro-check: A plate with a 1-inch edge crack (Y ~1.1) in a material with $K_{IC} = 50$ ksi$\sqrt{\text{in}}$ fails at 25 ksi stress. If the crack grows to 4 inches, will the critical stress be about (A) 12.5 ksi, (B) 50 ksi, or (C) 6.25 ksi? *(Use $\sigma_c \propto 1/\sqrt{a}$: crack length 4×, stress capacity halved -> ~12.5 ksi, answer (A).)*

K09.T01.S06 – Brinell hardness → UTS rule-of-thumb (steels)

Principle (Hardness vs Tensile Strength):

- For many steels, Brinell hardness can be used as a quick estimate of ultimate tensile strength. Treat it as an approximation for quick checks—not a substitute for a material spec.

- **Tensile Strength (TS)** is the maximum engineering stress a material can withstand in tension (often synonymous with Ultimate Tensile Strength, UTS). For many steels, there's an empirical relationship between hardness and UTS: basically, a harder steel is a stronger steel. This is because both hardness and tensile strength increase with things like higher carbon content, cold working, or certain heat treatments that make the steel's microstructure harder and stronger.

- A widely used correlation for **plain carbon steels** is:

- TS (psi) $\approx 500 \times$ BHN
- TS (MPa) $\approx 3.5 \times$ BHN

where BHN is Brinell Hardness Number (dimensionless). This comes from fitting data; for example, a steel of hardness 200 BHN will have UTS around 500 * 200 = 100,000 psi (≈ 690 MPa). It's an approximation (±10% maybe), but good enough for estimates.

- This conversion is handy on the exam if they, say, give you a hardness from a table or test and ask for approximate tensile strength (or vice versa). It's a quick way without doing a full stress-strain analysis.

- **Limitations:** This correlation holds for **steel** in particular. Other materials have their own correlations (if any). For example, the relationship for cast iron or aluminum will have different constants or none at all straightforwardly. So use it primarily for plain carbon and low alloy steels unless told it applies elsewhere. Also, at very high hardness (above ~500 BHN) or very low hardness, the linear approximation might break down slightly, but those are extremes outside common structural steel ranges.

- **Hardness testing:** For context, Brinell hardness involves pressing a steel (or tungsten carbide) ball into the metal and measuring indent size. Rockwell hardness uses a smaller indenter and dial readings (e.g., HRC scale used for hard steels, HRB for softer). They all correlate roughly. Brinell is nice for correlation because it uses a fairly large indent and is historically used to estimate strength. If given Rockwell C, sometimes conversion charts exist (Exam might provide one if needed). But you could also reason: a Rockwell C 30 steel is moderately hard (maybe ~280 BHN, which corresponds to ~ 980 MPa UTS). The FE won't expect you to know those conversions by heart – they'd either give a formula or a table to use. The key is understanding higher hardness means higher strength, and how to use any provided conversion.

Equation/Conversion Passport – Hardness to Tensile Strength (Steel)

Empirical conversion for plain carbon steel hardness to tensile strength

$$\text{TS (MPa)} \approx 3.5 \times \text{BHN}$$

$$\text{TS (psi)} \approx 500 \times \text{BHN}$$

(BHN = Brinell Hardness Number, no unit)

Variables and Context:

- TS = Tensile Strength (ultimate strength) of the steel. Units either MPa or psi depending on which version of the formula you use. This is typically the engineering tensile strength (peak stress on stress–strain curve).

- BHN = Brinell Hardness Number, determined from a standardized hardness test (diameter of indentation left by a 10 mm ball with 3000 kg load, etc.). It's essentially pressure (load/area) but reported as a number without direct units.

- The constant **3.5** (for MPa) is an approximate factor. For example, BHN 200 → TS ≈ 700 MPa (which is roughly 100 ksi). For psi, the factor 500 is basically 3.5 multiplied by 145 (since 1 MPa ~ 145 psi), let's check: 3.5 * 145 = 507.5, so they rounded to 500 for simplicity in psi. So using 500 is a neat, easy remember number in imperial.

Assumptions and Validity:

- **Material: plain carbon steel** (or similar steel). The microstructure typically is a mix of ferrite and pearlite, etc. For alloy steels it still holds reasonably but extreme alloys or heat

treatments (like case-hardened surfaces) might not follow the bulk correlation precisely. If the exam references this formula, they implicitly mean steel unless stated otherwise.

- **Uniform material:** The hardness test and tensile test sample should represent the same bulk material. If the surface is hardened (case hardening) but core is softer, the hardness might mispredict core strength. But that complexity likely won't enter an FE question unless conceptual (i.e., case vs core hardness concept).

- **Empirical, not exact:** Understand it's an approximation. The exam won't have you calculate this to super precision – answers will be phrased like "approximately what is the tensile strength" etc. Use the formula directly; don't overthink minor differences.

Limit checks:

- If BHN = 0 (the impossible scenario of a perfectly soft material that offers no resistance to indent), the formula gives TS = 0. That's logical: no hardness, no strength. Of course, even lead or butter has some hardness >0, but as a trend it fits.

- If BHN is high, say 600 (very hard steel, approaching the hardness of some tool steels or carbides), TS (MPa) ≈ 2100 MPa (which is extremely high strength, likely beyond typical steels and into specialized territory). Realistically, most structural steels range maybe 120–300 BHN (400–1100 MPa). At the high end, the relationship might yield a slightly conservative or liberal estimate, but within maybe ±10-15%. That's fine for FE answers typically.

- Cross-check: a steel of 150 HB typically has a yield ~275 MPa and UTS ~500 MPa. Our formula gives 150*3.5 = 525 MPa, close to UTS. A hardened steel of 500 HB might have UTS ~ 1700 MPa; formula gives 1750 MPa – in ballpark. So it doesn't wildly break down in range of interest.

Use vs. sibling info: Use this conversion rather than doing a full stress-strain if all you need is an estimate of strength from a hardness value. Conversely, if you have tensile test data (yield, UTS), you wouldn't bother with hardness correlation – you have the direct measurement. This is mainly for quick estimation or if hardness is given due to easier testing in field. Sibling relationships: sometimes there are hardness conversion charts between scales (Rockwell, Brinell, Vickers). The exam could supply a table or chart to convert, say, HRC to BHN, and then you use BHN to get strength. If they do that, follow the provided info. Another related piece: **strength ~ 3.45 * Vickers hardness number (HV)** for steel in MPa (since HV number is in kgf/mm², it coincidentally yields a similar numeric value as BHN and correlation factor ~3.3-3.45). But again, they'll likely stick to one scale or just state hardness without specifying scale if they intend you to use the formula (in context, BHN is often the default if not said, because Rockwell scales have letters). If a Rockwell hardness is given, they might expect you to either convert via a given table or recognize approximate BHN. Without a reference, I doubt they expect memorized cross-scale conversions, so presumably BHN will be used or provided.

Common exam traps:

- **Using wrong units factor:** If you try to use the 500 factor for MPa by accident—e.g., BHN 200—using 500 gives $200 \times 500 = 100{,}000$ MPa, which is nonsense (that's 100 GPa, beyond any material strength). Conversely, using 3.45 for psi: $200 \times 3.45 = 690$ psi (absurdly low for steel strength). So be sure which system you're in. The exam might help by phrasing: "Brinell hardness is 200. Estimate the ultimate tensile strength in MPa." Then you know to use 3.45. If they say "in ksi," you could compute in MPa then convert or directly use the psi correlation ($500 \times$ BHNgives psi, then divide by 1000 to get ksi: $500 \times 200 = 100{,}000$ psi $=$ 100 ksi).

- *Assuming validity for non-steels: If a problem gives hardness of say a brass or an aluminum, applying 3.5*BHN might not hold (the factor is different). Usually, the exam won't expect you to do that unless they explicitly say "assume a similar correlation" or provide it. In absence of info, don't apply steel's exact factor to other materials. If an aluminum alloy hardness is given, and no formula, a safe assumption is probably they won't ask for tensile strength unless they gave a chart or something. If they did, then use that given info.

- **Misinterpreting hardness value or scale:** For instance, Rockwell C 30 is not "30 BHN". Each scale's number is different. BHN ~ 280 might correspond to ~HRC 30. If they give "30 HRC" and you blindly treat it as BHN=30, you'll hugely underestimate strength. So watch units/scale. Usually, "HR" or a letter indicates Rockwell; Brinell might be just given as a number with "BHN" or "HB". Vickers might be given with "HV". Pay attention to any letters around the hardness value. The exam should clarify, but if not, context clues: BHN are typically in hundreds for metals; Rockwell C is typically 20-60 for hardened steels (and HRC won't be used for soft steel, they'd use HRB scale for that which has two digits as well but usually noted as e.g. 80 HRB).

- **Precision of answer:** Because this is approximate, the answer choices likely won't be super close to each other. They might say "about 1000 MPa, 700 MPa, 300 MPa, 150 MPa" for a BHN 200 steel. Using 3.5*200 =700 MPa clearly matches one. If they gave an option 750 MPa vs 700, that would be cruel unless they specified a more exact formula. So pick the one in the right range.

Exam Handbook Search Cues (Not affiliated with or endorsed by NCEES): hardness, Brinell, tensile strength, BHN, Rockwell, Vickers (if conversion charts are present)

Footnotes:

- *Hardness testing quirks:* The correlation works best for metals that work-harden somewhat. Annealed versus quenched states can affect how hardness relates to tensile strength slightly (because hardness test is a very localized plastic deformation, whereas tensile is bulk). But for the FE exam, that nuance is beyond what they'd expect. Just use the formula given (or found in the handbook reference section on Materials).

- *Other correlations:* Sometimes, another formula given for steel UTS (MPa) is $UTS \approx 3.45 \times$ BHN – pretty much the same as 3.5 times, just a bit different in constant. This difference (3.45 vs 3.5) is minor (1.4% difference) – likely due to rounding or specific data source. Don't fret, either would land on the same multiple-choice answer.

- *Rockwell to Brinell:* If needed, approximate: a mild steel ~ 120 BHN corresponds ~ RB 70; a harder steel ~ 300 BHN ~ RC 30; 600 BHN is off Rockwell C scale (that's like beyond 68 HRC, near tungsten carbide territory). So if you get a Rockwell C, you might convert roughly: an HRC of 20-30 is moderate steel (BHN maybe 250), HRC 40-50 is very hard (~400+ BHN, TS > 1300 MPa). But again, I suspect either BHN or a provided table.

Variations and Related Forms:

- **Other hardness scales:** The FE reference might list approximate conversions or at least mention multiple scales. If the question gives, say, "60 HRC" (which is really hard steel, like a file or bearing), you might not recall BHN. They might expect recognition that 60 HRC is extremely hard (~Rockwell C goes to 70 max). 60 HRC corresponds to roughly 655 BHN (very high) which by 3.5 gives ~2290 MPa. That's a tool steel-level strength. If an answer is in that ballpark vs much lower, you'd pick that. Usually though, they'd probably supply any needed conversion factor or just stick to BHN for simplicity.

- **Yield strength correlation:** Hardness correlates better to UTS than yield for many steels, but there are rough correlations to yield as well (like yield ~ (0.7-0.8)UTS for steels depending on alloy). If a problem needed yield from hardness, it might assume a proportion or provide data. Typically, if they give hardness, they want UTS.

- Non-steel note: For aluminum alloys, an approximate correlation is TS (MPa) ~ 3.3 × HV (Vickers hardness). If one had to guess and no info given, one might still multiply BHN by ~3 to get MPa as a ballpark. But I would caution: If they wanted that for a non-steel, they'd likely give guidance.
- Typical values: Some reference: Mild steel (~low carbon annealed): ~120 BHN ~ 400 MPa UTS; Structural steel (A36): ~130 BHN ~ 450 MPa UTS; High-strength bolt (quenched/tempered): ~300 BHN ~ 1050 MPa UTS; File/knife edge: ~600+ BHN ~ 2000+ MPa UTS. These align with everyday knowledge – files are very hard and brittle (and indeed very strong in tension but would shatter if you could pull them without bending). If a question asks to rank materials by strength given hardness, you can do so easily.

- **Hardness and machinability/toughness**: Harder steels (high BHN) are often less tough (more brittle) – think of a hardened knife vs a tough spring. So while hardness often goes with UTS up, it inversely correlates with ductility and toughness. The exam might slip in a question: "Given two steel samples, one annealed (lower hardness) and one quenched (higher hardness), compare their tensile strength and toughness." Answer: quenched one has higher tensile strength and hardness, but lower toughness (more brittle, lower fracture toughness or impact energy).

Special Notes (Calculator): If a precise conversion is needed, it's just multiplication—trivial for calculators. Just be careful with units. If you have BHN and want MPa, multiply by 3.45. If you want psi, multiply by 500. If you want ksi, either multiply BHN by 0.5(since $500 \times$ BHNgives psi, divided by 1000gives $0.5 \times$ BHNin ksi) or do $(\text{BHN} \times 500)/1000$. For example, BHN 200: TS $\approx 200 \times 0.5 = 100$ ksi. (Check: 100 ksi $= 100{,}000$ psi, and indeed $500 \times 200 = 100{,}000$ psi, consistent). So an even simpler memory: TS (ksi) $\approx 0.5 \times$ BHNfor steel. That's actually quite neat. If BHN 250, TS ≈ 125 ksi. For MPa, TS $\approx 3.45 \times$ BHNis already easy enough.

Explanation & Analysis: Let's work an example to illustrate use: "A steel gear has a Brinell hardness of 250. Estimate its ultimate tensile strength." Using the formula: TS $\approx 3.45 \times 250 =$ 862.5 MPa. If they wanted the answer in, say, MPa, you'd give $\sim$ 860 MPa(rounded). If in psi, $250 \times 500 = 125{,}000$ psi(which is 125 ksi). That's a pretty high strength, consistent with a hardened medium-carbon steel or so. Another scenario: "A steel specimen tested for hardness gives 100 HB. What does this indicate about its strength and likely microstructure?"* 100 HB is low ($\sim$ 345 MPa UTS, like mild low-carbon steel, perhaps annealed). It suggests the steel is quite soft and ductile (ferrite-pearlite structure, annealed). It's actually below typical structural steel hardness, so likely a very mild steel or even iron. The exam likely won't ask microstructure from hardness, but it could ask to compare two processes: e.g., "After quenching and tempering, the steel's hardness is 300 HB. If originally it was 150 HB, how much did the tensile strength increase?" You'd do original TS $\sim$ 518 MPa, new $\sim$ 1035 MPa, so about doubled.

Because hardness tests are quick and nondestructive (mostly), they're used in industry to estimate strength of in-service parts without doing a tensile test (which would destroy the part). So this correlation is practically important and often included in reference handbooks.

On the exam, be mindful if the question explicitly states "for steel" or if it's in the steel context. Don't apply it to something like "brass gear hardness 150 HB, what's strength?" unless you're sure the intent is to treat it similarly (brass might have different factor, but funnily 3.5 isn't terrible for some brasses either because they have similar indentation mechanics – but don't assume without prompt).

In summary, **hardness–strength correlation** gives a quick estimation: just multiply. Make sure to report the answer in the requested unit. Recognize that if hardness doubles, tensile strength roughly doubles (linear correlation in that range). And qualitatively, knowing a metal's hardness gives you a sense of its strength: high-hardness steels (like tools) are extremely strong but also brittle; medium-hardness steels (structural) have moderate strength and good toughness; low-hardness (annealed) are softer, lower strength but very ductile.

Quick micro-check: A steel with BHN = 200 is scratched by a file of BHN ~600. Is its tensile strength likely above or below 1000 MPa? *(200 BHN → ~700 MPa, so below 1000 MPa; the file at 600 BHN corresponds to >2000 MPa but brittle.)*

K09.T01.S07 – Physical & Thermal Properties: Density, Thermal Conductivity, Coefficient of Thermal Expansion, Thermal Diffusivity

Principle (Physical/Thermal Properties & Material Selection):

- Materials are often chosen not just for mechanical strength but also for their **physical properties** like density and thermal behavior. Key properties include: **density (ρ)**, **thermal conductivity (k)**, **coefficient of thermal expansion (α for CTE)**, and **thermal diffusivity a** (sometimes written α_{th} in heat transfer texts). Each affects performance in different ways.

- **Density (ρ)** is mass per unit volume (kg/m³ in SI). It matters for weight-critical designs: e.g., aircraft frames use low-density materials (aluminum, composites) to save weight; a flywheel might use high-density material to pack more mass in given volume. Typical densities: steels ~7850 kg/m³ (0.284 lb/in³), aluminum ~2700 kg/m³ (0.098 lb/in³), titanium ~4500, polymers ~900-1500, ceramics vary but often ~2000-4000, water 1000. On the exam, you might use density to compute weight (W=mg) or for buoyancy, or to compare which component weighs more. Also, density ties into material cost and inertia calculations. Ensure to distinguish density from specific weight (weight per volume) or specific gravity (density relative to water).

- **Thermal Conductivity (k)** is how well a material conducts heat (W/m·K). High k means heat flows readily (metals are high; e.g., copper ~400 W/mK, aluminum ~ 180 W/mK), low k means insulator (air ~0.025, polyurethane foam ~0.03, wood ~0.1 W/mK).

Engineers use high-k materials for heat sinks and low-k for insulation. On the exam, you may plug k into heat transfer equations (e.g., conduction $q = kA\Delta T/L$) or just need a qualitative sense (like "which material would dissipate heat fastest?" or "which handle stays cool?").

- **Coefficient of Thermal Expansion (CTE, α)** describes how much a material expands per degree of temperature increase (units: 1/°C or 1/K). It's often given in μstrain per °C (like 12×10^{-6} /°C for steel). If a temperature change ΔT occurs, a free material of length L will change length $\Delta L = \alpha L \Delta T$. This is crucial where temperature changes occur: e.g., thermal stress in restrained components, or joint materials with different α can cause cracking or warping. Typical CTE: plastics ~50–200×10^{-6}, aluminum ~23×10^{-6} /°C, steel ~12×10^{-6}, glass ~8×10^{-6}, Invar alloy ~1×10^{-6} (very low expansion). So aluminum expands about twice as much as steel per °C, which is why bimetal strips bend with temp (two metals with different CTE). On the exam, you might calculate thermal strain (ε_{th} = α ΔT) or a thermal stress if something is constrained ($\sigma_{th} = E\alpha\Delta T$ if fully restrained). Recognize that if something is allowed to expand freely, it won't develop stress, just strain. If constrained, thermal expansion creates significant forces (e.g., why rails have expansion joints).

- **Thermal Diffusivity (a or σ_{th})** combines conductivity, density, and heat capacity into one: it measures how quickly a material's temperature equalizes. Formally,

$$\alpha_{\text{th}} = \frac{k}{\rho c_p},$$

where c_p is specific heat capacity at constant pressure (J/kg·K).

Units of thermal diffusivity: m²/s. A high thermal diffusivity means the material responds quickly to temperature changes (it conducts heat fast relative to how much heat it can store). Metals tend to have high α_{th}because they conduct well and have moderate heat capacity; water has low α_{th}because even though it stores a lot of heat (high c_p), it doesn't conduct well. Example values: $\alpha_{\text{th}}$of metals $\sim 10^{-4}$to 10^{-5} m^2/s (e.g., aluminum $\sim 9\times10^{-5}$, steel $\sim 1\times10^{-5}$), insulating materials $\sim 10^{-7}$or less. If you heat one side of a material, high diffusivity means the other side heats up quickly; low diffusivity means there's a lag (it's "thermal inertia"). The exam might not ask for numeric calc unless giving values, but conceptually: e.g., "Which material would be best for a cooking pan in terms of thermal response? (High thermal diffusivity like aluminum so it heats quickly and evenly). Which for insulating handle? (Low diffusivity like wood – even though wood's surface might get hot, the heat doesn't penetrate quickly)."

Equation Passport – Thermal Diffusivity

Thermal Diffusivity – indicates how fast heat spreads through a material

$$\alpha_{\text{th}} = \frac{k}{\rho\, c_p}$$

Variables and Units:

- α_{th} = thermal diffusivity (m²/s). Sometimes given in mm²/s in industry (1 mm²/s = 1×10^{-6} m²/s).
- k = thermal conductivity (W/m·K).
- ρ = density (kg/m³).
- c_p = specific heat capacity at constant pressure (J/(kg·K)). (If using constant volume c_v for solids, it's nearly same as c_p for a solid, difference is negligible as solids don't do expansion work like gases do). Units J/kgK. ρc_p together is volumetric heat capacity (J/(m³·K)).

Assumptions and Scope:

- Material is homogeneous (uniform k, ρ, c through volume) and isotropic. Many composites can have direction-dependent conductivity, etc., but FE problems will treat given values as uniform.

- c_p is assumed constant over the temperature range in question (small or moderate temperature changes). This is fine for most solids within not-too-extreme ranges.

- This is a property used in transient heat conduction. If doing the full heat equation, α_{th} appears in $\partial T/\partial t = \alpha\nabla^2 T$. But the FE exam usually won't require solving PDEs – they might just use α for qualitative or simple calculations like Biot or Fourier numbers in lumped capacitance (Heat Transfer section might use it).

- The formula is valid if c_p is per mass. If c_p were given per mole, don't use here; FE will stick to per mass usually.

Limit checks:

- If a material has extremely high thermal conductivity k(like silver or copper) and moderate $\rho$and c_p, $\alpha_{\text{th}}$is high. If a material has extremely high heat capacity or density, $\alpha_{\text{th}}$is low (because it can soak up heat without much temperature rise, thus delaying propagation). For example, water has huge $c_p \sim 4180$ J/kgK, and $\rho \sim 1000$, so $\rho c \sim 4.18\times10^6$ J/m^{3}K, with $k \sim 0.6$ W/mK, $\alpha \sim 0.6/4.18\times10^6 = 1.4\times10^{-7}$ m^2/s– very low. Water heats slowly internally despite good convective cooling ability. Metals: say steel $c_p \sim 500$ J/kgK, $\rho = 7850$(so $\rho c \sim 3.9\times10^6$), $k \sim 50$, $\alpha \sim 50/3.9\times10^6 = 1.28\times10^{-5}$ m^2/s, which is higher. Aluminum: $c_p \sim 900$, $\rho = 2700$($\rho c \sim 2.43\times10^6$), $k \sim 180$, $\alpha \sim 180/2.43\times10^6 = 7.4\times10^{-5}$ m^2/s, even higher. So indeed Al conducts and changes temp quicker than steel or water.

- If k → 0 (perfect insulator), $\alpha_{th} \to 0$: heat hardly spreads. If ρ or $c_p \to 0$ (a hypothetical massless or no heat capacity material), $\alpha_{th} \to \infty$: any tiny heat flows raises temp and spreads instantly – not physical beyond maybe extremely light materials or very low specific heat (which doesn't really occur in solids, since even the lowest c_p solids like some polymers are still a few hundred J/kgK). So extremes check out logically.

Use vs. sibling equations: Use this to find a missing property if given the other two and α_{th} (though more likely you'd compute α_{th} from others). If confronted with a transient heat problem, you might use α_{th} to compute a Fourier number (Fo = a t / L², for instance). Sibling concepts: **thermal effusivity** (√(kρc) which relates to how materials exchange heat at interfaces) – probably not in FE exam. Also, don't confuse this α with the **coefficient of thermal expansion α**; they share the symbol α but are totally different. We clarify that to avoid confusion (see footnotes).

Common exam traps:

- **Mixing up α's:** The Greek letter α is commonly used for both *thermal diffusivity* and *linear thermal expansion coefficient*. They have different units (m²/s vs 1/K). If you see α in a heat transfer context or next to k, it's likely diffusivity; if in a structures/strain context or next to a ΔT in a strain formula, it's expansion coefficient. The exam may explicitly say "thermal diffusivity" or

"coefficient of expansion" to avoid ambiguity. Just be alert to context.

- **Unit conversion:** If given k in say Btu/(hr·ft·°F), ρ in lbm/ft³, c in Btu/(lbm·°F), you could still plug into α = k/(ρc) *if consistent units*. Actually those units are consistent in USCS (they'd yield ft²/hr). But likely they'll stick to SI to reduce hassle. If you do have to convert, it might be easier to convert each piece to SI, compute, then back-convert. The reference likely has conversion factors if needed.

- **Neglecting temperature units consistency:** In k/(ρc_p), note that ΔT units cancel because k has per K and c has per K in denominator, so as long as both use same ΔT unit (K or °C, difference is moot as they increment same). So you don't worry about temperature units as long as they're consistent (K vs °C difference only in absolute scale, not interval). That's usually fine.

- **Forgetting specific heat units:** Specific heat often given in J/(kg·K). Sometimes they might give it as J/(kg·°C) which is equivalent (since K and °C size same). If they give in say kJ/kgK, convert to J/kgK by ×1000. Or if in cal/gK, convert to J (1 cal ~4.184 J). Minor but worth double-checking.

Exam Handbook Search Cues (Not affiliated with or endorsed by NCEES): density, thermal conductivity, specific heat, thermal expansion coefficient, thermal diffusivity, $\alpha = k/(\rho c)$

Footnotes:

- **Specific heat vs specific heat capacity:** They're used interchangeably. Just note it's per mass. In some fields (thermodynamics) they use c_p and c_v, but for solids $c_p \approx c_v$ as volume change is negligible for heating at constant pressure. FE might not even mention c_v for solids.

- **Units recall:** Common units: Density: $\mathrm{kg/m^3}$(also $\mathrm{g/cm^3}$, $1\ \mathrm{g/cm^3} = 1000\ \mathrm{kg/m^3}$), Thermal conductivity: $\mathrm{W/(m \cdot K)}$(also $\mathrm{J/(s \cdot m \cdot K)}$same thing, or $\mathrm{Btu/(hr \cdot ft \cdot\ ^\circ F)}$in USCS), CTE: per $^\circ\mathrm{C}$(like $1 \times 10^{-5}\ ^\circ\mathrm{C}^{-1}$), Specific heat: $\mathrm{J/(kg \cdot K)}$(or $\mathrm{kJ/(kg \cdot K)}$), Thermal diffusivity: $\mathrm{m^2/s}$. If something is given in unusual units, convert. E.g. density $7.85\ \mathrm{g/cm^3}$for steel, multiply by 1000 to get $7850\ \mathrm{kg/m^3}$.

- **Understanding CTE usage:** If a rod is heated $\Delta T$and not constrained, you can calculate ΔLeasily. If it is constrained to original length, that ΔL"wants" to happen but can't, so it results in thermal stress. A formula for thermal stress (if fully prevented expansion) is $\sigma_{\mathrm{th}} = E\alpha\Delta T$. The exam might test that in a simple scenario: e.g., "A steel beam is rigidly fixed at both ends. If temperature rises $30^\circ\mathrm{C}$, what stress is induced? (Given $E$and α, plug in)." Watch units: Ein Pa, αin $1/\,^\circ\mathrm{C}$, ΔTin $^\circ\mathrm{C}$yields Pa stress. Often easier: compute $\mathrm{strain_{free}} = \alpha\Delta T$(like $12 \times 10^{-6} \cdot 30 = 3.6 \times 10^{-4}$). If fully prevented, actual strain $= 0$, so thermal strain of $3.6 \times 10^{-4}$is "prevented" by elastic strain of equal magnitude in opposite sign, which requires stress $E \cdot 3.6 \times 10^{-4} = (200 \times 10^9 \cdot 3.6 \times 10^{-4}) = 72 \times 10^6\ \mathrm{Pa} = 72\ \mathrm{MPa}$(compressive if heated and locked in place). That kind of problem is common. If partial constraint, or if it's not completely fixed, that's more complex but likely beyond FE (except maybe asking qualitatively, like in statically indeterminate structures section possibly).

- **Thermal conductivity context:** Could be used in steady state conduction or fin problems (but those belong to Heat Transfer topic). In materials context, likely conceptual or property lookup usage. Possibly "which metal is best for a heat exchanger, copper or steel?" (Answer copper, higher k). Or "why do engine parts use aluminum?" (light and good heat conduction to shed heat from combustion).

Variations and Material Selection Notes:

- Typically, **metals**: high density (except Al, Mg are light), high thermal conductivity (especially copper, aluminum, gold, etc., iron is moderate ~50-80, stainless steels lower ~16 because alloys, and nickel alloys low ~20), moderate CTE (steel ~12, Al ~23, more expansion in lighter metals usually due to bonding nature differences). **Polymers**: very low thermal conductivity (~0.1-0.5 W/mK, good insulators), low to moderate density (~1000 kg/m³, foamed plastics even less), high CTE (plastic can expand a lot when heated, e.g., ~100×10^{-6} for some plastics, which is several times steel). **Ceramics**: low to moderate thermal conductivity (some ceramics like alumina ~30 W/mK, others like silica ~1 W/mK), fairly low CTE (~5-8 for glasses and ceramics, that's why cookware glass doesn't crack easily – low expansion), high melting points. These differences drive selection: e.g. ceramics for high-temp stability and low expansion (but brittle), metals for structural strength and thermal conduction (but heavy), plastics for lightweight and insulation (but low strength, low temp limit). They love to test these trade-offs conceptually.

- **Material property tables:** in practice, you often look up density, k, α, etc., for candidate materials. The FE Reference likely has a table of common materials with these properties (like that big table we saw from the PDF with thermal conductivity etc.). In exam scenario, you could be given an excerpt or be expected to know relative values. For example, "Given four materials with their properties (density, k, α), which is best suited for a precision optical mirror that sees temperature swings?" You'd pick the one with lowest α (so it doesn't distort with temperature) – likely a ceramic or an Invar alloy. Or "which material would minimize heat loss in a skillet handle?" – pick low k (wood or plastic). That's how they integrate practical knowledge.

- **Thermal diffusivity usage:** If you see a problem about heating or cooling time, diffusivity might be used. For example, "Material A has twice the thermal diffusivity of Material B. If objects of equal size/material are heated, which cools faster initially?" – Material A changes temp faster due to higher α. Or if a question involves a Biot number or Fourier number, you'd compute α * t / L² etc. That's more in heat transfer, but just to note.

Special Notes (Calculator & Problem-Solving): For straightforward calculations: use α_{th} = k/(ρc). If each number is large, do stepwise to avoid mistakes. Eg: ρ=8000, c=500, product 4,000,000; k=40, then $\alpha=40/4\times10^6 = 1\times10^{-5}$ (0.00001). When computing thermal expansion: ΔL = α L ΔT, plug carefully, watch out if L in mm then ΔL you get in mm if α in per °C but ensure the length units align. Possibly convert α to per °C in same unit scale as L: e.g., $\alpha=12\times10^{-6}$ /°C means 12×10^{-6} m per m per °C. If L is 2 m, $\Delta L = 12\times10^{-6}\ 2\ \Delta T$ (in m). If L was 2000 mm, maybe convert L to m or adjust α to per mm (which would be 12×10^{-6} per m, per m means if L in m, you get m; if L in mm, convert mm to m or α to per mm: 12×10^{-6} per m = 12×10^{-3} per 1000 mm ~ 1.2×10^{-5} per mm, easier to just convert L). Thermal stress: use E in consistent units with stress output desired (Pa yields Pa). Honestly, units are the main watch-out in these calculations. The numbers themselves are usually plug-and-chug.

Explanation & Analysis: Let's examine some situations:

Density: Suppose a question: "Two cubes of equal volume, one aluminum and one steel. Which weighs more and roughly by what factor?" Steel's density ~7850, aluminum ~2700 kg/m³. Steel is ~3

times heavier for same volume. So steel cube weighs ~3x aluminum cube. If you had to compute the weight difference in Newtons or lbf given a size, you'd multiply volume by density by g. For instance, a 0.1 m³ block of steel: mass = ρV = (7850 kg/m³)(0.1 m³) = 785 kg, weight = mg = (785)(9.81) ≈ 7.70×10³ N. They might ask ratio or actual difference. This is straightforward if you know densities or can find them in reference.

Thermal conductivity: If they ask which material for a heat sink, you pick one with high k (copper or aluminum). If they ask to calculate a heat flux, you might do $q = k\Delta T/L$ if given geometry – but that goes to heat transfer territory. However, perhaps a combined question: a bimetal junction – on one side steel, other copper, heat flows – they might require continuity of heat flux and different temperature gradients due to different k (again, more likely in heat transfer section). Under Materials, likely just ID high vs low conductors.

Thermal expansion: Example: "An aluminum rod ($\alpha = 23 \times 10^{-6}$ /°C, length 2 m)experiences a 50°Crise in temperature. How much longer does it get (free expansion)?" $\Delta L = 23 \times 10^{-6} \cdot 2 \cdot 50 = 0.0023$ m = 2.3 mm. That's noticeable. If same for steel rod ($\alpha = 12 \times 10^{-6}$), $\Delta L = 12 \times 10^{-6} \cdot 2 \cdot 50 = 0.0012$ m = 1.2 mm. So aluminum expands almost twice as much as steel for same ΔT(consistent with ratio of α's). If the question was about stress when constrained: say that aluminum rod is pinned at ends and cannot expand, then stress induced $= E\alpha\Delta T$. If E(aluminum) ~ 70 GPa, then $\sigma = 70 \times 10^9 \cdot 23 \times 10^{-6} \cdot 50 = 70 \times 10^9 \cdot 1.15 \times 10^{-3} = 8.05 \times 10^7$ Pa ≈ 80.5 MPa(compressive because the rod wants to expand but is held). If steel, $\sigma = 200 \times 10^9 \cdot 12 \times 10^{-6} \cdot 50 = 120 \times 10^9 \cdot 6 \times 10^{-4}$.

If fully restrained: axial strain = 0 = σ/E + αΔT ⇒ **σ = −EαΔT** (negative = compressive for heating).

Aluminum $\left(E \approx 70\ GPa, \alpha \approx 23 \times \frac{10^{-6}}{°C}, \Delta T = 50°C\right)$:

$$\sigma \approx -(70e9)(23e-6)(50) \approx -80\ MPa$$

Steel $\left(E \approx 200\ GPa, \alpha \approx 12 \times \frac{10^{-6}}{°C}, \Delta T = 50°C\right)$:

$$\sigma \approx -(200e9)(12e-6)(50) \approx -120\ MPa)$$

So under same conditions, steel sees higher thermal stress because its $E$is higher (even though $\alpha$is lower, the product $E\alpha$might be bigger for steel: $E\alpha$steel ~ 2.4×10^9, aluminum ~ 1.61×10^9in those units, indeed steel's $E\alpha$ ~ 1.5 ×aluminum's, giving stress ~ 1.5 ×). If asked which material is more prone to thermal stress when constrained, it's the one with higher $E\alpha$product. Usually steel, being stiffer, can build more stress. Sometimes engineers use lower Eor lower αmaterials to reduce thermal stress (Invar has super low α, used in precision instruments to avoid expansion).

Thermal diffusivity example: "Compare the ability of copper vs stainless steel to respond to temperature changes." Copper has very high k ~ 400 W/mK, ρ ~ 8960, c ~ 385 J/kgK, so $\alpha \sim \frac{400}{8960 \cdot 385} = \frac{400}{3.45 \times 10^6} \approx 1.16 \times 10^{-4}$ m²/s. Stainless steel: k ~ 16 W/mK, ρ ~ 8000, c ~ 500, so $\alpha \sim \frac{16}{4 \times 10^6} = 4 \times 10^{-6}$ m²/s, which is about 30 times lower. That means copper heats up and cools down much faster than stainless (copper pan quickly equalizes temperature, stainless pan has hot spots and slower to heat evenly unless copper bottom is added). If a question said "A copper ball and a stainless steel ball of same size are heated in an oven and then taken out to cool, which cools faster initially?" The one with higher diffusivity (copper) will equalize its internal temperature faster*. However, note cooling to environment also depends on surface properties (emissivity, convection) – but ignoring that, internally copper doesn't hold heat as much relative to conduction. So it'll cool more uniformly and likely faster. They might not go that deep, but it's the concept.

Material selection synergy: A tricky example: "You have a support that must carry load and also not expand too much with heat. You can pick from aluminum, steel, or Invar. Which do you choose?" Likely Invar (very low CTE) if expansion control is paramount and some strength can be sacrificed (Invar's E ~ 145 GPa, yield ~ 250 MPa, fairly okay; but its standout feature is α ~1×10^{-6}). If both weight and expansion matter moderately, maybe aluminum (light but more expansion) vs steel (heavy but less expansion) – it's a trade-off scenario. Usually, they frame it so one property is clearly the priority.

To conclude this subtopic: **understand what each property means physically and typical relative values across material classes.** You should be able to qualitatively compare and plug simple formulas. They often integrate this knowledge in scenario questions or ask for an implication ("What happens if an aluminum part is constrained and temperature rises? It experiences compressive stress and possible buckling if slender." Or "why must a gap be left in rail tracks? To accommodate thermal expansion." Those conceptual uses are fair game.)

Quick micro-check: If you have a bimetal strip of aluminum and steel riveted together and heated, which side will expand more and cause the strip to bend towards the other? *(Aluminum expands more, so the strip will curve with aluminum on the outer (longer) side and steel on inner side of curvature.)*

K09.T01.S08 – Using Material Property Tables for Design

Topic Intro (Material Property Tables): Engineers frequently rely on property tables to select materials that meet design criteria. On the FE exam, you won't memorize every value – instead, you'll use given tables (like in the exam handbook) or compare provided data. **Being fluent in reading these tables is crucial**. Typically, a table will list materials in one column and various properties in others (mechanical properties like yield strength, tensile strength, hardness; thermal properties like conductivity, CTE; physical like density; maybe electrical resistivity if relevant). Knowing how to quickly find and interpret the right value can save time and prevent mistakes.

How to Read and Interpolate:

- Identify the correct material and condition (some tables separate by temper/heat treatment, alloy designation, etc.). Ensure you're looking at the right row for the material in question. For example, "Aluminum 6061-T6" vs "Aluminum 2024-T4" – different strengths. Or "AISI 1020 steel (annealed)" vs "AISI 1020 (cold-drawn)". These details significantly change values like strength and hardness, so pick the exact match if available. If an exact match isn't listed, choose the closest or a conservative estimate.

- Check units and **column headings**. A good table passport habit: note units for each column. Are strengths in MPa or psi? Is density given in kg/m³ or perhaps g/cm³? The exam might mix unit systems, so double-check. For instance, a table might show density as "(lb/in³ (Mg/m³))" indicating two units. Or thermal conductivity might have separate columns for metric and USCS. Use whichever the question's context is in, or convert as needed.

- **Interpolation:** If a property is given at specific temperatures or compositions and your value lies between, linear interpolation is usually acceptable unless the table suggests otherwise (e.g., if values change non-linearly with temp, but often within small ranges linear is fine). For example, if thermal conductivity of a metal is 200 W/mK at 20°C and 220 at 100°C, for an intermediate 60°C you might interpolate ~210 W/mK (assuming roughly linear in that range). The exam could expect that if they don't provide a formula but do give multiple points. They might also avoid requiring interpolation by giving exactly listed values in the question. If needed, do it carefully: fraction = (desired - low) / (high - low), then apply to property difference. Show a quick calc to avoid error.

- **Do not extrapolate beyond table range unless you have high confidence.** If a table stops at 300°C and you need a value at 350°C, and no guidance given, it's risky to extrapolate as properties can change drastically (especially near phase changes). The exam likely won't force that without giving you some formula or info. If it happens, mention the uncertainty or pick the nearest known value as an approximation (probably safer to pick at 300°C as a lower-bound or something if absolutely forced).

Units and Source Lineage:

- The table data in references are typically compiled from experiments or standards. For example, tensile strengths might come from ASTM specs, thermal conductivities from handbooks. You may find such tables redrawn from known sources (like the big table we saw from Van Vlack's data). They typically are representative values at room temp (unless specified otherwise).
- Units: The table passport should clearly state units. Let's exemplify a mini table with SI and US units for clarity:

Table: Typical property ranges for common material families

Use this table for intuition and reasonableness checks only. For problems requiring a specific number, look it up in the FE Reference Handbook and use the exact units provided there.

Material family (examples)	Density (kg/m³)	Young's modulus E (GPa)	Strength metric (typical range)	Thermal conductivity k (W/m·K)	CTE α (µm/m·°C)	Notes you should state in assumptions
Aluminum alloys (wrought, heat-treated)	2600–2800	68–74	**Yield** ~150–500 MPa	120–235	21–24	Strength depends strongly on temper/heat treatment; E varies little across common alloys.
Carbon & low-alloy steels (mild to HSLA)	7700–7900	190–210	**Yield** ~200–550 MPa	40–60	11–13	A36-type steels are near the low end of yield; E is very consistent across steels.
Austenitic stainless steels (300-series)	7900–8100	180–200	**0.2% proof** ~170–350 MPa	14–25	16–18	"Yield" is often reported as 0.2% proof; lower k and higher CTE than carbon steel.
Copper alloys (brasses/bronzes)	8300–8900	90–130	**Yield** ~100–400 MPa	60–170	17–21	Wide spread due to composition and cold work; k varies a lot across copper alloys.
Titanium alloys (α/β alloys)	4400–4700	100–120	**Yield** ~700–1100 MPa	5–10	8–10	High specific strength; low k; CTE lower than steels/aluminum.
Polymers (unfilled thermoplastics)	900–1400	0.5–3	**Yield** ~20–80 MPa	0.1–0.4	50–150	Properties are temperature-sensitive; CTE is large compared with metals.
GFRP laminates (glass/epoxy composites)	1600–2000	**Along fiber:** 15–45 **Transverse:** 5–12	**Tensile (along fiber)** ~300–1000 MPa (laminate dependent)	0.2–1.0 (direction dependent)	**Along fiber:** 5–12 **Transverse:** 20–40	**Anisotropic:** always state direction and laminate layup; through-thickness k is usually low.
Concrete (normal-weight)	2200–2500	20–35	**Compressive** ~20–50 MPa (tension much lower)	1–2.5	7–14	Don't use "yield"; use compressive strength and note brittleness.

Room temperature assumption: Unless otherwise stated, values are approximate at ~20–25 °C.
Ductile vs brittle: For ductile metals, "strength" usually means **yield or proof strength**; for brittle materials, use **ultimate/compressive** strength as appropriate.
Direction matters: Composites and many natural materials are **anisotropic**; report properties with the loading direction.
Exam practice: Use the FE Reference Handbook as the authoritative source for any numeric property in a worked solution; use the ranges above only to verify your result is plausible.

Typical Exam Moves:

- **Material selection questions:** Given a scenario (e.g., need a lightweight, thermally conductive material that can operate at moderate stress), pick the material whose properties best fit. You'd scan for low density, high thermal k, decent strength – perhaps aluminum alloys. If corrosion resistance was also mentioned, maybe stainless if weight allowed, or a composite if strength/weight needed. The exam might frame it like: "Which of the following materials is most suitable for X application?" with some key property demands. Use the table: eliminate ones that fail a key criterion (like too heavy or not strong enough or cannot take heat, etc.).

- **Numeric lookup for problem-solving:** Some questions might give you a property table snippet (or reference you to the handbook page) to retrieve a value and plug into a formula. For example: "Calculate the thermal stress in a brass rod (material properties given in table) when temperature increases 50°C." You'd get E and α from the table for brass, then do $\sigma = E\alpha\Delta T$. Or "How long will it take heat to diffuse through a 1 cm polymer sheet compared to a metal sheet?" Use thermal diffusivities from table to set up ratio or compute time via L^2/α formula (transient conduction).

- **Cross-property reasoning:** They might test if you know some properties correlate. For instance, generally stronger metals are heavier (most strong metals are steel or titanium which are dense, except composites break the rule). High thermal conductivity often correlates with electrical conductivity (so copper, aluminum high in both, whereas steel is mediocre in both). If they give you an unfamiliar material but mention it's an electrical insulator, you might infer it's low thermal conductor too (like ceramics). Or if they say "lightweight and low thermal expansion alloy known as Invar", even if you didn't recall density, you know low CTE is the standout.

- **Pitfalls with tables:** One might misread a row or column. Always double-check: align the row and column properly (use a ruler on scratch if needed). If the table is wide, follow along carefully to not mix values from adjacent rows. On computer-based exam, you might scroll or use search; ensure you got the right entry. A classic mistake is taking the wrong material's value or reading MPa as if it were psi. For example, yield 250 could be MPa (which is ~36 ksi) but someone might think it's in psi and treat it as ultra-low (250 psi). Units usually clarify with something like "(MPa)" in header. If not explicit but given context (like E=200 for steel, that's definitely GPa, not psi in any case), use engineering judgment.

Common pitfalls:

- **Unit confusion:** as highlighted, check the fine print of the table. Some tables list US and metric together, some separate. - **Temperature of data:** Many properties change with temperature (e.g., yield strength drops with heat, thermal conductivity changes). If a table lists properties "at 20°C" but your problem is at 300°C, be cautious. The exam might expect you to comment qualitatively that strength is lower at high temp or to use some provided factor. If not given, and if the change is significant, the safe design approach is to assume a much reduced strength or pick a material known to handle heat (like stainless retains strength better than aluminum at 300°C). But usually, if a problem needs high-temp data, they'll provide it or direct you.

- **Table not available for unusual materials:** If a question involves, say, a new composite or something not in the handbook, they must give you the needed properties in the question stem. Use those. If you find yourself searching for a material property not provided anywhere, the correct approach might be reasoning or eliminating impossible choices rather than raw data.

Material Table Pitfalls Example: Suppose a table snippet shows: Aluminum alloy – Density 2.7 g/cm³, Tensile Strength 300 MPa; Titanium alloy – Density 4.5 g/cm³, Tensile Strength 900 MPa; Magnesium alloy – Density 1.8 g/cm³, Tensile Strength 250 MPa. If asked "which has best strength-to-weight ratio (UTS/ density)?" you'd compute: Al 300/2.7=111 MPa per (g/cm³), Ti 900/4.5=200, Mg 250/1.8=139. So titanium wins on strength/weight here. If one just looked at strength, they'd pick Ti anyway, but this confirms even per weight it's best. However, if cost or corrosion was a factor, answers might differ. Ensure you pick according to asked criteria only.

Reading Example: If provided the big table from earlier with columns like Resistivity and Thermal Conductivity for many elements, and question: "Which metal has higher electrical conductivity, Silver or Gold?" The table might list resistivities or conductivities; one must correctly interpret that lower resistivity = higher conductivity. Silver's resistivity (~1.6×10^{-8} Ω·m) vs gold (~2.4×10^{-8}). So silver conducts better. They could also ask "which metal has a higher melting point, Iron or Aluminum?" The table likely lists melting point; just compare values (Fe ~1538°C, Al ~660°C). That's straightforward if you locate the numbers correctly.

Common exam strategy with tables: Underline or circle the needed value once found to keep your place. Cross-check with a second property if possible (like if you know steel's density roughly and the table says 7.8, good; if it said 0.28 you'd realize that's probably in lb/in³ in another unit column). If an answer seems off (like calculating a weight and getting something unrealistic), double-check if you took density in wrong units.

In the exam environment: The FE Reference PDF is searchable. If you recall a keyword like "density of aluminum", a search might lead you to the table or section. But that can be slow if done too often. Better to be familiar with the layout: likely a "Materials" section where such tables reside. Knowing approximate values helps as a sanity check even after you pull from a table.

Table Passport Summary:

- Title/purpose: e.g., "Common Material Properties at 20°C" – so you know it's baseline values.

- Read by matching material name exactly, paying attention to any condition (temper, etc.)

- Interpolate if needed for intermediate values (linearly unless said otherwise), don't extrapolate crazily.

- Units clearly noted – convert if your calculation units differ.

- For design questions, apply those values appropriately in formulas or comparisons.

- Be mindful of any footnotes (sometimes tables have footnotes like " *at 500°C", or "** single crystal value" etc. Unlikely in exam context unless they give a snippet including it – read them if present).

Common pitfalls when rushing: mixing up rows (reading the next line's value by accident), reading the wrong column (especially if many columns per property at different temps, etc.), ignoring that

something is in Celsius vs Kelvin (for melting point, it's fine since just offset 273, but if it said "Temp = 68°F" that might mean something for property context – again, not likely in straightforward tables).

Final tip: When in doubt, **choose conservatively** for design. If selecting a material and two seem close, the safer one (stronger, more heat resistant, etc.) is usually the intended answer unless cost/weight trade says otherwise. The exam typically has one clearly correct based on given info though, so trust the data.

Now, let's illustrate selection via a quick scenario:

Scenario: Designing a heat exchanger tube that must be light, thermally conductive, and withstand moderate pressure. Choices: Copper, Aluminum, Steel. Table shows: Copper (density 8960, k=400, yield ~70 MPa), Aluminum (2700, k=167, yield ~250 MPa), Steel (7850, k=50, yield ~250 MPa). Copper has excellent k but is heavy and relatively weak (yield 70 MPa is low for pure copper). Aluminum has good k, very light, decent strength. Steel strong but heavy and low k. Likely Aluminum is best compromise (especially an alloy could have >250 MPa yield, decent conductivity). Unless extremely high thermal conduction needed, then maybe copper (but weight penalty). The exam would expect: Aluminum tube offers good conduction at a fraction of weight of copper, and strength similar to steel for moderate pressures (with corrosion considerations aside). So answer: Aluminum alloy.

Exam Handbook Search Cues (Not affiliated with or endorsed by NCEES): tables, "Properties of materials", specific material names (like searching "Aluminum 6061" or "AISI 1020" in the PDF might jump to tables), "Thermal conductivity of copper", etc. The handbook likely has a contents or index too; one could find "Density" or "Thermal expansion" in index leading to tables.

Topic 02 - Stress-Strain Diagrams

Topic Introduction: Stress–strain diagrams are fundamental graphs that show how a material deforms under tensile loading, plotting **stress** (force per area) against **strain** (deformation relative to original length). For the FE Mechanical Exam, you need to know how to read these curves and extract key material properties like yield strength, Young's modulus, and tensile strength. This matters on exam day because many questions involve identifying these properties or understanding material behavior (elastic vs. plastic deformation). A typical question might give you a stress–strain graph (or a description of one) and ask for a specific point (e.g. the **yield point** or **ultimate tensile strength**), or require you to calculate deformation using the elastic modulus. Mastering this topic means you'll quickly recognize what a stress–strain curve is telling you about a material's strength and ductility, and avoid common pitfalls (like confusing engineering stress with true stress). Now, let's break down the subtopics one by one, following our blueprint "passport" format for each core concept.

K09.T02.S01 – Engineering Stress–Strain Curve Key Points

Principle (Overview): The engineering stress–strain curve from a tensile test (here, for a ductile metal like mild steel) captures the entire journey of a material as it is stretched until it breaks. Key points on this curve mark transitions in material behavior:

- **Proportional limit:** the end of the initial linear (straight-line) portion where stress is directly proportional to strain (Hooke's law holds). Up to here, the material behaves elastically.

- **Yield point (yield strength):** the stress level at which the material first starts to yield and undergo permanent (plastic) deformation. For many metals, yield strength is defined by the **0.2% offset** method (a slight strain offset ≈ 0.002 on the x-axis); mild steel uniquely shows a distinct yield point with a small drop after an "upper yield" – but in general, the yield point is where the curve first deviates from linearity.

- **Ultimate tensile strength (UTS):** the **maximum engineering stress** reached on the curve. It's the peak of the graph – beyond this point, the material can no longer sustain the same load on the original cross-section as necking occurs.

- **Fracture point:** the end of the curve, where the specimen breaks. This point occurs at a stress lower than the UTS on the engineering curve (because the cross-sectional area has significantly reduced in the necked region, causing the load to drop before final failure). The strain at fracture (elongation) is a measure of **ductility** (often reported as percent elongation).

Diagram title and role: *Uniaxial Engineering Stress–Strain Curve* – helps you identify material properties (strength, ductility) from a tensile test. This graph is your map of how a material responds to being stretched.

Axes and quantities: Horizontal axis is **engineering strain**, $\epsilon = \Delta L/L_0$ (no units, often noted as in/in or mm/mm, sometimes as a percentage). Vertical axis is **engineering stress**, $\sigma = F/A_0$ (units: Pa or psi, since it is the applied force F divided by the original cross-sectional area A_0). For mild steel, typical ranges are up to ~ 0.2 (20%) strain and a few hundred MPa of stress.

Key regions and points: From (0,0) up to the proportional limit, the curve is linear (slope = E, Young's modulus). The **elastic region** ends at the **yield point**, where plastic behavior begins. Between yield and UTS, the material **strain hardens** – meaning it requires increasing stress to continue deforming plastically. The highest point is UTS (the material's tensile strength). Beyond UTS, the curve drops due to **necking**, and the end of the curve is the fracture point (failure).

How to read it (exam-style): If a question gives you a stress–strain graph, first identify the linear portion – its slope is the **Young's modulus** E. Next, find the first deviation from linearity – that stress is the **yield strength**. The peak stress value on the graph is the **UTS**, and the strain at break (the x-value at the end) indicates **ductility** (percent elongation = final $\epsilon \times 100\%$). You might be asked, for example, "What is the yield strength of this material?" – you'd look for where the curve leaves the straight line. Or, "Approximately what is the modulus of elasticity?" – you'd take the slope of the initial straight segment (rise over run in stress–strain coordinates).

Common misreads: Don't confuse the **UTS** with the stress at fracture – on an engineering stress–strain curve for a ductile material, UTS is higher than the final fracture stress. Also, note that the **yield strength** is often a bit lower than the proportional limit for materials without a clear yield point (due to using the 0.2% offset definition); on a graph, that means the yield point might be slightly offset from where the curve visibly departs from linearity. Avoid mistaking the initial tiny curvature (if any) for yield – sometimes there's a gradual transition. And remember that **elastic recovery** happens if you unload before the yield point: exam questions might hint that if stress never exceeded yield, the specimen returns to zero strain (no permanent set).

Exam Handbook Search Cues (Not affiliated with or endorsed by NCEES): *stress–strain curve*, *yield strength*, *ultimate tensile strength*, *proportional limit*, *fracture strain*, *ductility* (These are keywords you could search in the exam reference to find relevant info on material properties.)

Footnotes:

- *Units:* Engineering stress is typically given in **MPa (N/mm²)** in SI or **psi** in USCS. 1 MPa $= 10^6$ Pa, and 1 psi ≈ 6895 Pa. Strain is dimensionless (e.g. $\epsilon = 0.10$ is a 10% elongation). Always convert % to a decimal when using formulas (5% = 0.05).

- *Yield point conventions:* Many metals (like steel and aluminum) don't show a sharp "hook" on the curve. In these situations, yield strength is commonly determined using the **0.2% offset method**: start at $\varepsilon = 0.002$, draw a line parallel to the initial elastic (linear) slope, and take the point where that line intersects the stress–strain curve. That intersection's stress is the yield strength. Mild steel is an exception that often exhibits a distinct yield drop (upper and lower yield points); the exam will typically clarify which definition to use if needed (usually default to 0.2% offset yield strength unless an "upper yield" is explicitly mentioned).

- *Ductility measures:* **Percent elongation** (%EL) and **percent reduction in area** (%RA) are two measures of ductility obtained from the tensile test. %EL is $(L_f - L_0)/L_0 \times 100\%$ (where L_f is

the final length at break), and %RA is $(A_0 - A_f)/A_0 \times 100\%$ (using cross-sectional area before and after fracture). High %EL or %RA means the material is very ductile. While the exam may not ask for these specifically by formula, understanding that a long "tail" on the strain axis means high ductility can help in qualitative questions.

Variations and Typical Values:

- **Ductile vs. brittle behavior:** A **ductile material** (like low-carbon steel) has a long plastic region and a noticeable yield point and UTS, as shown above. A **brittle material** (like cast iron or ceramics) typically has no significant plastic region – it might exhibit a near-linear stress–strain curve up until fracture, with the fracture occurring shortly after the proportional limit (so yield strength ≈ UTS in practice, and very low strain at break). On the exam, know that a steep, relatively short curve indicates a stiff, brittle material (high E, breaks early), whereas a stretched-out curve indicates a ductile one.

- **Typical strengths:** To calibrate your intuition, mild steel might have a yield strength on the order of **250–400 MPa** and a UTS around **400–550 MPa**, with 20–30% elongation. Aluminum alloys could have yield strengths more like 50–300 MPa with lower E and higher elongation for very ductile alloys. These numbers aren't for memorization but give a sense: steel is stronger (higher stress values) and stiffer (higher E) than aluminum, for example. The exam may present qualitative comparisons, e.g., *"Which material is likely represented by a given stress–strain plot?"*.

- **Temperature effects:** Increasing temperature generally lowers both yield strength and tensile strength and increases ductility (the curve becomes 'softer' and longer). Cold-working (plastic deformation below recrystallization temp) raises yield strength and UTS (the material's curve gets higher in the plastic region) but reduces ductility; this is essentially pre-applied strain hardening. These effects could be referenced in conceptual questions about material processing.

Special Notes:

- **Calculator use:** If you need to estimate a slope or compute a strain from the graph during the exam, use the **Delta (Δ)** calculation: pick two convenient points in the linear region (e.g., at 0.001 strain and 0.002 strain) and their corresponding stresses (say 200 MPa and 400 MPa), then compute $E \approx \Delta\sigma/\Delta\epsilon$ (here, $(400 - 200)\text{MPa}/(0.002 - 0.001) = 200{,}000\ \text{MPa} = 200\ \text{GPa}$). The allowed calculators have no issue with basic arithmetic – just be careful with scientific notation if dealing with large values like 200×10^9 Pa. It's often easier to convert to GPa or MPa to avoid mistakes.

- **Units consistency:** If an exam problem mixes units (say, force in kN and area in mm² for stress), convert to a consistent set (kN to N, mm² to m²) *before* computing stress to get E in Pa. Alternatively, compute stress in the mixed units (like N/mm² gives MPa directly) and know that 1 N/mm² = 1 MPa. The exam handbook provides unit conversion factors if needed.

Explanation & Analysis (Step-by-Step): The engineering stress–strain curve is basically a fingerprint of a material's mechanical behavior:

1. **Elastic region (OA in the figure):** From the origin up to the proportional limit, the material obeys Hooke's Law ($\sigma = E\epsilon$). If you unload anywhere here, the material will return to its original length with no permanent strain – think of it like a spring that hasn't been stretched too far. Physically, in this region, atomic bonds are stretched but not broken; when the load is removed, they snap back to their original positions.

2. **Yield point (A):** At the yield point, permanent deformation begins. It's like the material "gives way" a bit. In mild steel, you might see a small drop after the upper yield point – that's a quirk where dislocation movement causes a sudden yield. In other metals, yield is more gradual, hence the 0.2% offset rule to define it. After this point, some part of the strain will **not** vanish upon unloading – the material will be a little longer than before. On exam day, recognizing the yield strength is crucial for questions about safety factors or allowable stress.

3. **Plastic region with strain hardening (AB to C):** Beyond yield, the curve rises again. The material is undergoing plastic deformation – dislocations are moving irreversibly – but as it deforms, it actually gets stronger (up to a point) because of **strain hardening**. Imagine bending a paperclip: after yielding, it takes more force to continue bending it than it did right after it first yielded. Point B would be the end of the yield drop (if any), and from B to C, the metal is hardening, requiring increasing stress to drive more plastic strain. The **ultimate tensile strength** at C is the highest stress the material sustains. Internally, by UTS the material's cross-section starts to thin significantly (necking onset).

4. **Necking to fracture (C to D):** After UTS, the load-carrying capacity falls. The "neck" (a local thinning in the specimen) means the stress based on original area (engineering stress) goes down, even though the material might still be strengthening locally. Eventually, the specimen breaks at point D (fracture). The strain at D (total elongation) includes both uniform elongation and the concentrated deformation in the neck. If you unloaded right before D, the material would not return to zero strain; you'd be left with a permanent set equal to the strain at the unloading point.

5. **Post-fracture analysis:** Often, exam problems won't go beyond the fracture – but they might ask *before* fracture, e.g., "Given a certain strain (within plastic region), what is the stress?" In such cases, if it's beyond yield, you can't use $E\epsilon$ (Hooke's law) anymore; you'd typically need the curve or additional info (like a given strain-hardening equation or assumption of linear work hardening, which is usually beyond FE scope unless a simplistic model is provided). Generally, the FE Mechanical questions will stick to asking: identify those key points (yield, UTS) or compute something assuming elastic behavior (using E).

In summary, mastering the engineering stress–strain curve lets you **read a material's strength and ductility** at a glance. For the FE exam, focus on recognizing the yield point (the boundary between elastic and plastic) and the UTS, understanding what each means (yield = permanent deformation starts, UTS = strongest point before necking, fracture = failure), and knowing how to get Young's modulus from the slope. With this, you can tackle questions about material properties confidently.

K09.T02.S02 – Engineering vs. True Stress–Strain Curves

Principle (Overview): *Engineering vs. True* – When a tensile test is performed, engineers record load and deformation and calculate **engineering stress** and **engineering strain** using the *original* dimensions of the specimen. However, as the material stretches and especially after it starts **necking**, the cross-sectional area shrinks and the material's actual stress state is different from what the engineering values indicate. **True stress** and **true strain** account for these changes: true stress uses the *instantaneous* (current) area, and true strain sums the incremental strain as the length changes.

The difference is minor in the elastic and early plastic range but becomes significant once large plastic deformation and necking occur. On the FE exam, you should grasp the conceptual difference: true stress–strain curves keep rising until fracture for ductile materials, whereas engineering stress–strain curves peak at UTS and then fall. Some questions might ask "why does the engineering stress drop after UTS while true stress continues to rise?" or require you to convert an engineering strain to a true strain. Understanding these definitions will help you avoid mistakes when interpreting or calculating stresses at large deformations.

Equation Passport: Engineering vs. True Measures – *Relating load and deformation to stress and strain, before and after significant deformation.*

- **Engineering Stress:** $\sigma = \frac{F}{A_0}$, where F is the applied force and A_0 is the original cross-sectional area of the specimen. *Purpose:* This is the nominal stress used for design and basic material specs, assuming the cross-section hasn't significantly changed. It's easy to compute from initial dimensions.
- **True Stress:** $\sigma_T = \frac{F}{A}$, where A is the **actual cross-sectional area** under load at that moment. *Purpose:* This represents the actual stress the material experiences at its reduced section. It's more accurate during plastic deformation, especially once necking starts and A decreases substantially.
- **Engineering Strain:** $\epsilon = \frac{\Delta L}{L_0}$, where ΔL is the change in length and L_0 is the original gage length. *Purpose:* A simple measure of how much the material has elongated relative to its initial length. Valid for small to moderate deformations.
- **True Strain:** $\epsilon_T = \ln(1+\epsilon) = \int_{L_0}^{L} \frac{dL}{L}$, where ϵ is the engineering strain and L is the current length. *Purpose:* A measure of deformation that adds up each infinitesimal stretch relative to the length at that moment. **True (logarithmic) strain** adds up each incremental stretch relative to the *current* length. For uniaxial tension,

$$\varepsilon_T = \ln\left(\frac{L}{L_0}\right) = \ln(1+\varepsilon)$$

For tensile elongation, **true strain is smaller than engineering strain** for the same final length (they are nearly equal only when strain is small). As elongation becomes large, **engineering strain increasingly overestimates** the accumulated deformation compared with true strain.

Variables and Units:

- F: applied force (units: N in SI, lbf in US units). - A_0: original cross-sectional area (m² in SI, in² in USCS). - A: instantaneous cross-sectional area under load (same units as A_0; $A \leq A_0$ and gets significantly smaller once necking occurs). - σ: engineering stress (Pa or psi, calculated as if area stayed at A_0).

- σ_T: true stress (Pa or psi, force divided by actual area A). - ΔL: change in length, $L - L_0$ (m or in). - L_0: original length (m or in).

- L: current length at a given moment (m or in; at fracture L_f is the final length). - ϵ: engineering (nominal) strain (dimensionless, often expressed as a decimal or %). - ϵ_T: true (logarithmic) strain (dimensionless).

Assumptions and Scope:

- These relationships assume **uniform deformation** in the gage length *until necking*. Before necking, the material's cross-section shrinks uniformly along the length (due to Poisson's effect), and using true stress is straightforward. Once necking starts, stress becomes highly localized at the neck – true stress at that location can still be defined using the minimum area, but the calculation assumes you measure that instantaneous area.

- Engineering stress–strain is perfectly fine (and standard) for describing material behavior up to the UTS. It's used in design because components are usually designed to stay in the elastic or modest plastic range (and it's easier to measure).

- True stress–strain is used for material science and forming processes analysis, especially to understand how materials behave under large plastic deformations (like metal forging, rolling, etc.). True strain adds via integration, which assumes each small deformation is accumulated – this formula $\ln(1+\epsilon)$ holds for monotonic (one-direction) loading in tension. (If you unload/reload, things get more complex – but that's beyond FE exam scope.)

Limit Checks (Sanity Tests):

- At very **small strains** ($\epsilon \to 0$), true strain $\epsilon_T \approx \epsilon$ (because $\ln(1+\epsilon) \approx \epsilon$ for tiny ϵ). So for elastic or small deformations, engineering vs. true makes virtually no difference – good to remember, you don't need to worry about "true" values in those cases.

- If the cross-sectional area **does not change** at all during loading (a hypothetical perfectly rigid material or an unrealistic assumption), then $A = A_0$ always and thus $\sigma_T = \sigma$. In reality, area always reduces when a material is stretched (due to Poisson's ratio effect), but up to yield the reduction is very small.

- As elongation becomes large, **engineering strain ϵ grows faster than true strain ϵ_T**, because $\epsilon_T = \ln(1+\epsilon)$ increases more slowly than ϵ. For example, at $\epsilon = 0.20$ (20% elongation), $\epsilon_T = \ln(1.20) \approx 0.1823$ (18.23%). Not a huge difference at 20%. But at $\epsilon = 1.0$ (100% elongation, length doubled), $\epsilon_T = \ln(2) \approx 0.693$ (69.3%). At $\epsilon = 2.0$ (200% elongation, length triple), $\epsilon_T = \ln(3) \approx 1.099$. So the gap widens with large deformation.

- After **necking starts**, engineering stress goes down with increasing strain (because F drops quickly once the specimen can't hold as much load), but true stress often continues to climb until just before fracture. In fact, the true stress at the point of fracture can be the highest stress the material ever experiences (since A has gotten very small). A sanity check: if given final diameter or area at fracture, you can compute true stress at break and see that it's higher than the engineering UTS.

Use vs. Sibling Equations: Use **true stress/strain** formulas instead of engineering ones **when accuracy at large plastic strains or necking is required**. If a problem gives you data about changing cross-sectional area or asks for "true stress" or "logarithmic strain," that's your cue to switch to the true definitions. Otherwise, for typical elastic/plastic questions (small strains or when only initial dimensions are known), stick with engineering stress–strain for simplicity. **Never mix them in one calculation** (e.g., don't plug an instantaneous area into an engineering stress formula or vice versa). If a question provides an "engineering stress–strain curve," use the

original area for any calculations; only use the instantaneous area if you're explicitly dealing with a true stress.

Common Exam Traps:

- **Mixing up area usage:** A classic mistake is to calculate stress at fracture using the original area when the problem implicitly wanted the true stress. For instance, if a problem says "The specimen's diameter at fracture is X mm under a load of Y kN, what is the true stress at fracture?", you must use the **reduced area** (from the final diameter) to get σ_T. Using A_0 (original area) would give the lower engineering stress.

- **Percent vs. fraction:** When computing true strain using $\ln(1+\epsilon)$, make sure ϵ is in decimal form, not a percentage. If $\epsilon = 20\%$, use 0.20 in the formula: $\epsilon_T = \ln(1.20)$, *not* $\ln(1+20)$!

- **Identifying which curve is which:** If shown two curves on the same plot (some references overlay engineering and true stress–strain), remember: the **true stress–strain curve lies above the engineering curve in the plastic region** (because true stress accounts for area reduction, it doesn't drop off at necking). At the start, both curves coincide (since differences are negligible in the elastic range). So if the exam has a conceptual question like "Which curve represents true stress–strain?", look for the one that does *not* drop after the UTS.

- **Units consistency:** The formulas for stress are straightforward, but be cautious with units – e.g., if force is given in kips (1000 lbf) and area in in^2, the stress in psi might need conversion to, say, MPa if comparing to a material property given in metric. The exam might give mixed units to test your unit conversion skills.

Exam Handbook Search Cues (Not affiliated with or endorsed by NCEES): *engineering stress*, *true stress*, *engineering strain*, *true strain*, *necking*. (These terms will help locate any reference info or equations about the difference between nominal and true measures.)

Footnotes:

- *Poisson's ratio effect:* As a material stretches, it usually gets thinner in width. The constant volume assumption (valid for metals in plastic deformation to a first approximation) means $A \cdot L \approx A_0 \cdot L_0$ for uniform deformation (this holds until localized necking). Using this, one can derive $\epsilon_T = \ln(A_0/A)$ as well – but careful, that assumes volume constancy and uniform reduction, which breaks at necking. The exam likely won't need this formula explicitly, but it explains why true stress rises: as A shrinks, F/A grows even if F doesn't.

- *Logarithmic strain in practice:* The benefit of true strain's logarithmic definition is that strains can be directly added. For example, two successive deformations of 10% (engineering) are not exactly 20% total engineering strain (since the second 10% is on a longer length), but in true strain they add: $\ln(1.10) + \ln(1.10) = \ln(1.10^2) = \ln(1.21)$, which is $\epsilon_T \approx 0.191$ (equivalent to 19.1% engineering strain). This property is more useful in manufacturing calculations than in the FE exam, but it's good to know why true strain is defined that way.

- *When necking occurs:* In a typical ductile metal, necking begins at UTS on the **engineering** curve. On a **true stress** curve, you wouldn't see a drop at that point – instead, the curve might continue up a bit and then end at fracture. However, even true stress eventually falls if one could track it post-necking because F drops precipitously at final failure; but the maximum true stress is often at the moment of fracture. The exam won't require plotting true curves, but understanding this trend can clarify conceptual questions on why one curve differs from the other.

Variations and Related Forms:

- If you need to convert an **engineering stress** to a **true stress** at a given large strain (assuming uniform strain up to that point), there's a simple relation (derivable from constant volume) for uniform elongation: $\sigma_T = \sigma\,(1+\epsilon)$ and $\epsilon_T = \ln(1+\epsilon)$. This holds *before* necking. For example, at 20% engineering strain, true stress $\approx 1.2 \times$ engineering stress at that same point. This formula isn't explicitly in the handbook, but it's a quick conversion if needed.

- **Necking criterion:** A material begins to neck when it loses the ability to harden further, mathematically when $d\sigma_T/d\epsilon = 0$. For a simple power-law hardening material $\sigma_T = K\epsilon_T^n$, necking starts at $\epsilon_T = n$ (true strain equal to strain-hardening exponent). While this is more of a material science detail, recognizing that necking = UTS could be useful if the exam asks something like "what is happening at the ultimate tensile strength point?".

Special Notes:

- **Calculators & True Strain:** All FE-approved calculators have a natural log (ln) function, so you can directly compute true strain. For instance, to find ϵ_T for 30% elongation, enter ln(1.30) to get ≈ 0.262. Ensure you're comfortable switching between percent and decimal. Also, if you're asked for *percent* true strain, don't forget to convert the result from decimal (e.g., 0.262 → 26.2% true strain).

- **Interpreting Problem Statements:** If a problem gives initial and final dimensions (length or area) and asks for "strain" or "stress", pay attention to wording. If they simply say "strain", by default assume engineering strain unless "true" is specified or the context (large deformation) strongly implies it. Similarly, if they mention a "drop in stress after the tensile strength", they're talking about engineering stress–strain behavior.

Explanation & Analysis: Let's clarify *why* these differences exist:

- **Conceptual difference:** Engineering stress–strain treats the specimen as if it's not changing shape (using original dimensions throughout), while true stress–strain acknowledges that as the specimen stretches, it gets longer and thinner. Imagine pulling on a piece of taffy: the farther you pull, the thinner it gets. The engineering calculation would keep using the taffy's original thickness, which makes it look like the material is getting weaker after a point (because it can carry less load at constant area). The true calculation uses the actual thinner cross-section, which reveals that the material is still strengthening (up until just before it breaks).

- **Before necking:** deformations are fairly uniform along the length and the cross-sectional area reduction is small. Engineering vs. true stress won't differ by more than a few percent in this stage. So if a question is about yield strength or moderate plastic strain (say 5% or 10%), you can practically treat them the same unless told otherwise.

- **At and after necking:** once the material hits UTS, a local constriction forms. The **load F starts to drop** because the specimen can't support as much with the reduced area. Engineering stress $\sigma = F/A_0$ therefore drops. True stress $\sigma_T = F/A$ at the neck, however, might still be rising because although F drops, A is dropping even faster. This is why a true stress–strain curve for a

ductile metal typically shows a peak at fracture, not at an earlier UTS. Essentially, **UTS (engineering)** marks the onset of instability (necking) rather than the absolute material strength.

- **Practical implications:** In design, we use engineering stress–strain data (yield strength, UTS, etc.) because components are sized based on original dimensions. However, when analyzing metal forming or how much a material can deform in total, true strain is more convenient. For FE exam purposes, you might get a question like: *"Given the same data, the true stress at fracture is higher than the engineering stress. Explain why."* The answer: because the cross-sectional area is smaller at fracture, so the actual stress (force/actual area) is higher than the nominal stress (force/original area). Or, *"What is the benefit of true strain?"* Answer: it allows adding sequential deformations and accurately describes large strains.

- **Key takeaway:** If you see the term "true stress" or "logarithmic strain" on the exam, switch your mindset – they're likely testing that you know these use instantaneous geometry. If no such keywords appear and the context is standard material properties, stick to engineering stress–strain definitions. By keeping these concepts straight, you'll avoid confusion on any question that ventures into the territory of large deformations or conceptual differences in material response.

K09.T02.S03 – Elastic vs. Plastic Deformation and Young's Modulus (Strain Hardening Behavior)

Principle (Overview): Every stress–strain diagram can be divided into two main regions: **elastic** and **plastic**. Understanding the distinction is crucial. In the **elastic region**, deformation is temporary – remove the load and the material springs back to its original shape. The slope of this region is the **Young's Modulus** E (also called **modulus of elasticity**), a fundamental material constant that measures stiffness. In the **plastic region**, deformation becomes permanent – once you've exceeded the yield point, some strain remains even after unloading. As loading continues in the plastic zone, many metals exhibit **strain hardening**: the material becomes stronger (its resistance to further deformation increases), which is why the stress–strain curve climbs upward after yield. Eventually, strain hardening is overcome by damage (like void formation, microcracks), leading to necking and fracture. For the FE exam, you should be comfortable identifying elastic vs. plastic behavior, calculating or using Young's modulus, and understanding that **yield strength marks the transition**. Typical questions might ask for the modulus given a stress and strain, or ask conceptually what happens beyond yield (e.g., "what is strain hardening?" or "why does a material require increasing stress to continue deforming plastically?"). Let's break down the key formula and concepts.

Equation Passport: Hooke's Law (Linear Elasticity) – *Relates stress and strain in the elastic region of a material.*

- **Name and purpose: Hooke's Law** – computes the **stress** in a material under elastic deformation, or vice versa, by a linear relationship. It's used to predict how much a material will stretch (or shorten) under a given stress as long as we haven't exceeded the elastic limit.
- **Professional form:** $\sigma = E\,\epsilon$, where the stress σ (Pa or psi) is proportional to the strain ϵ (dimensionless) through the constant E (Pa or psi). This can be rearranged as $\epsilon = \sigma/E$ for solving strain, or $\sigma = E\,\epsilon$ for stress.

Variables and units:

- σ: normal stress (units: Pa in SI, which includes N/m², or often given in MPa; in US units, psi). It represents intensity of internal force.
- ϵ: normal strain (no units, often expressed as a decimal or with a suffix like "in/in"). It represents relative deformation.
- E: Young's Modulus (also in Pa or psi; often expressed in GPa or MPa for convenience). It's a material property – high E means the material is very stiff.
- **Assumptions and scope:** Hooke's Law assumes **linear elastic behavior** – meaning the material has not exceeded the proportional limit. It also assumes the material is homogeneous and follows linear stress-strain response in tension (for most metals, this holds up to yield). Beyond the elastic limit, the relationship no longer holds (the material yields and the stress-strain curve deviates from linear). Also, this form is for **normal (tensile/compressive) stress**; a similar linear relation exists for shear stress $\tau = G\,\gamma$ with shear modulus G. The exam will stick to linear regimes unless specifically stating otherwise.

Limit tests:

- If $\sigma = 0$, Hooke's law gives $\epsilon = 0$ (no load, no deformation – checks out).
- If $\epsilon = 0.001$ (0.1% strain) and $E = 200$ GPa (like steel), then $\sigma = 200\text{ GPa} \times 0.001 = 0.2\text{ GPa} = 200\text{ MPa}$. That's a reasonable stress in the elastic range for steel. If someone mistakenly treated a large plastic strain as elastic, say $\epsilon = 0.10$ with $E = 200$ GPa, they'd get $\sigma = 20$ GPa (which is 20,000 MPa, impossibly high for a tensile test) – a clear sign something's wrong (you've gone beyond elastic regime or units are off).
- As $\epsilon \to$ **yield strain**, σ approaches yield stress. Beyond that, real materials won't follow $\sigma = E\epsilon$; if you plug in a bigger ϵ, you might get a σ that exceeds the material's strength – that's unphysical. So never use Hooke's law past yield in calculations.
- **Use vs. sibling equations:** Use $\sigma = E\epsilon$ instead of more complex stress-strain relations **when you are within the elastic range**. If the problem is about deflections, vibrations, or initial stress responses (and doesn't indicate plastic deformation), Hooke's law is your go-to. In contrast, **do not use Hooke's law for the plastic region** – once yield is passed, you'd need either the given stress–strain curve or a plasticity model (which is beyond FE scope unless a simple hardening rule is provided). Also, remember the **shear version**: $\tau = G\,\gamma$ for shear stress–strain, where $G = \frac{E}{2(1+\nu)}$ (if you need to find the shear modulus from E and Poisson's ratio ν).

Common exam traps:

- Confusing E (Young's modulus) with other moduli or stiffness terms. For example, some might confuse it with **tangent modulus** (slope of the stress-strain curve at a point in plastic region) or think it changes after yield – it doesn't; E is essentially constant for a given material in its elastic regime. Also, E is not the same as the slope of

the entire stress-strain curve if the curve isn't linear throughout – it's strictly the initial slope.

- Mixing units: E for metals is on the order of 10^9 Pa (gigapascals). If you plug stress in Pa and strain in dimensionless, you'll get E in Pa. If you accidentally put stress in MPa with strain in dimensionless, your calculated E will come out in MPa. For instance, 200 MPa stress / 0.001 strain = 200,000 MPa, which should be reported as 200 GPa. Keep track of units or convert to a single system.
- **Permanent vs. elastic strain:** A question might describe a scenario: a rod is loaded past yield and then unloaded – what is the permanent strain left? To solve that, you use Hooke's law for the elastic unloading part only. Students sometimes try to use E across the total strain which is wrong – you have to subtract out the plastic part. The trick is: total strain = elastic strain + plastic strain. Elastic strain = σ/E (using the stress at unloading point, which is yield if fully unloaded from just past yield). The remainder is plastic permanent set. Understanding this concept could be the key to a question on unloading.

Exam Handbook Search Cues (Not affiliated with or endorsed by NCEES): *modulus of elasticity*, *Young's modulus*, *elastic deformation*, *plastic deformation*, *Hooke's law*, *strain hardening*. (These terms connect to sections on material properties and mechanics that describe elastic/plastic behavior.)

Footnotes:

- *Young's Modulus vs. other moduli:* E is for tensile/compressive elasticity. **Shear modulus** G handles shear deformations (often $G \approx E/2.6$ for steels since $\nu \approx 0.3$). **Bulk modulus** K relates to volumetric compression (for instance, how compressible a material is – not commonly needed in FE except maybe conceptually; $K = \frac{E}{3(1-2\nu)}$ for isotropic materials). The exam may not directly quiz K, but G does show up in contexts like torsion of circular shafts.

- *Units of E insight:* 1 Pa is a very small stress. That's why typical E values (like 200 GPa for steel) are huge in Pa – 2×10^{11} Pa. In U.S. units, steel's $E \approx 29 \times 10^6$ psi (29 million psi). Memorize one or two reference values (like steel's E) as a reality check on answers. If you calculate an E that is off by an order of magnitude, re-check unit conversions.

- *Elastic limit vs. proportional limit:* Technically, **proportional limit** is where the curve first departs from linearity; **elastic limit** is the stress beyond which permanent deformation occurs. For many materials these are practically the same, and often "yield point" is in that vicinity. On the exam, it's usually safe to consider the yield strength as the demarcation of elastic vs. plastic (since they define yield by the 0.2% offset, which is essentially the elastic limit). Just note the terminology: if they ask for proportional limit and give you a graph, it's the end of the straight line portion.

- *Strain hardening vs. work hardening:* These are synonyms. They describe the mechanism where plastic deformation makes a metal stronger (increasing dislocation density impedes further dislocation motion). In the stress–strain curve, strain hardening is why the curve rises after yield. On an exam question, if they say a material was "cold-worked" or "strain-hardened," it means its yield strength has increased (and ductility decreased) due to prior plastic deformation.

Variations, Related Concepts, and Typical Values:

- **Typical E values:** Know the ballpark: Metals have high E (steel ~ 200 GPa, aluminum ~ 70 GPa, brass ~ 100 GPa, titanium ~ 110 GPa). Polymers have very low E (Polyethylene maybe ~1 GPa or less, which is why they're flexible). Ceramics and composites vary but often are quite stiff (carbon fiber in direction of fibers ~ 150–250 GPa). Concrete ~ 30 GPa. Wood (along grain) ~ 10 GPa. These numbers are just context; you won't need exact values, but you might need to judge relative stiffness.

- **Elastic vs. plastic in design:** In machine design (beyond FE), you usually design so that operating stresses are below yield (purely elastic). However, some processes intentionally go plastic (like stamping sheet metal). The exam might have qualitative questions like "What happens to the modulus of elasticity after yielding?" Correct answer: it stays the same material property, but the material no longer follows a linear stress-strain path. Or "Why is yield strength more important than tensile strength in design?" Because once you hit yield, the part has deformed permanently and is essentially failed for precise applications, whereas UTS is more about ultimate load capacity (important for safety but not for maintaining functionality).

- **Strain hardening exponent:** In material science, plastic stress-strain for many metals can be modeled by $\sigma_T = K\epsilon_T^n$ (the Hollomon equation) in the strain-hardening region, where n (the strain hardening exponent) is between 0 and 1. Higher n means more strain hardening (the curve rises more steeply). For example, annealed copper might have $n \approx 0.5$ (very ductile, lots of hardening), whereas a high-strength steel might have $n \approx 0.1$–0.2. This detail is unlikely to be tested quantitatively on FE, but qualitatively, "a material with a higher strain hardening exponent will have a more pronounced increase in stress after yield."

- **Elastic and plastic strain energy:** The area under the stress–strain curve can be thought of as energy per volume. The elastic area (under the linear part) is recoverable energy (it'll be released when unloading – think springback), whereas the plastic area is mostly dissipated as heat and creating defects. One specific term: **modulus of resilience** = energy per volume up to yield (area under elastic portion). **Toughness** = total energy per volume to fracture (area under the entire curve). If the exam asks which material is "tougher," you're looking for the one with the larger area under the curve (both strength and ductility contribute). These concepts tie into elastic vs. plastic behavior: a high yield strength and decent ductility = high toughness.

Special Notes:

- **Using the Exam Handbook:** The exam's reference will list E for some common materials and maybe formulas like $\sigma = E\epsilon$. However, be prepared to apply these without explicit prompts. For instance, a question might just describe a rod stretched within elastic range and give you force, length, area, asking for elongation – you'd combine stress = F/A and $\epsilon = \sigma/E$ to solve for $\Delta L = \epsilon L_0$. Practice doing these quickly: it's plug-and-chug once you identify it's an elastic deformation problem. (Remember, $\Delta L = \frac{FL_0}{AE}$ for a prismatic bar – a formula that might appear in the handbook under Mechanics of Materials.)

- **Calculator tip:** Solving $\sigma = E\epsilon$ is straightforward, but if you're dealing with a very stiff material and small strains, you might get a big number times a small number. Use your calculator's scientific notation correctly. For example, $\epsilon = 0.0005$ and $E = 210$ GPa,

you might do $210 \times 10^9 \times 0.0005 = 1.05 \times 10^8$ Pa (which is 105 MPa). It's easy to slip a decimal – keep track of powers of ten.

Explanation & Analysis (Step-by-Step): To solidify your understanding, let's walk through the elastic-to-plastic transition and strain hardening conceptually:

1. **Elastic deformation:** When you first apply load to a metal bar (think of gently pulling a steel spring), the atoms in the material are stretched a tiny bit from their equilibrium positions. They act like tiny springs themselves – the interatomic forces resist the pull linearly (for small displacements). In this regime, doubling the force doubles the stretch: that's the essence of Hooke's Law and linear elasticity. The material will return to its exact original shape if you let go. On a stress–strain plot, this is the straight-line portion. If you know σ and ϵ in this range, $E = \sigma/\epsilon$ is constant. For example, a 100 MPa stress causing 0.0005 strain means $E = 200GPa$. On exam problems, if you see small strains like 0.001 and moderate stresses, you're dealing with elasticity and should apply Hooke's law.

2. **Yield point and plastic deformation:** As you increase the load, you'll reach a point where the atomic "springs" can't elastically stretch any further without rearranging. In metals, this is when dislocations start to move – essentially, planes of atoms slip past each other. This is the yield point: additional strain now causes permanent shifts in the material's internal structure. If you unload right after yielding, the stress returns to zero but a residual strain remains (the atoms have a new arrangement). On the graph, this is where the line departs from linearity. Practically, if you've yielded a steel bolt, it might have elongated permanently and will no longer fit as before. The exam might ask something like, "If a sample is loaded beyond yield and then unloaded, how do you determine the permanent strain?" – you'd subtract the elastic recovery (using σ_{unload}/E) from the total strain at unloading.

3. **Strain hardening (strengthening during plastic flow):** After yielding, as you continue to pull, the material doesn't just deform at the same stress level – it actually starts to resist more. Why? Because as dislocations multiply and tangle, the material finds it harder to undergo further plastic slip. It's like running into more and more roadblocks as you push the material – the result is you have to apply higher stress to continue plastic deformation. This is seen as the rising curve after yield. So even though the material is permanently deforming, it's also getting **stronger** in terms of stress capacity (up until the point of ultimate strength). This is why the curve can go up by, say, 50% beyond the yield stress before reaching UTS. In a question, if they ask "What is happening in the material between the yield point and ultimate strength?", the answer is strain hardening – the material is gaining strength due to plastic deformation.

4. **Necking and failure (transition to fracture, beyond strain hardening):** Eventually, the material can't gain any more strength from hardening because damage mechanisms kick in (voids form in metals, for example). The cross-sectional area begins to reduce significantly in one localized spot (neck). At this point, even though the material might still be getting stronger on a per-area basis, the reduction in area and internal damage cause the overall load it can carry to drop. On the engineering stress–strain curve, that's the downward slope after UTS, ending in fracture. In the true stress sense, the material might still be seeing increasing stress at the neck until just before it snaps. Exam-wise, detailed fracture mechanics is usually not covered, but qualitatively: ductile fracture is preceded by noticeable plastic deformation (necking), whereas brittle fracture happens suddenly with little plasticity.

5. **Elastic vs. plastic summary:** To decide if something is elastic or plastic in a problem, compare the stress to the yield strength. If a problem says "a steel rod is loaded to 50 MPa" and you know yield is ~250 MPa, it's safely elastic – use Hooke's law for any deformation calc. If it said "loaded to 300 MPa", that exceeds yield – meaning the rod has yielded (plastic deformation). If they then unload it, you'd need to compute how much was elastic vs. plastic as discussed. The FE exam may not dive deeply into unloading scenarios, but you should know the concept of elastic recovery.

6. **Why E matters:** Young's modulus is often tested indirectly. For example, a vibration or deflection problem might involve E. Or a materials question might simply ask, "Which material is more rigid?" giving you two E values. Or, "for the same dimensions and load, which material will deform less?" – the one with higher E. So, E is the measure of stiffness. It does not tell you about strength (yield or UTS) directly; some materials (like cast iron) have a high E similar to steel but are much weaker in yield/UTS. Always differentiate: *stiffness* (resistance to elastic strain) comes from E, while *strength* (resistance to plastic deformation or failure) comes from yield and tensile strengths.

7. **Why yield matters more than tensile (in design):** One last note connecting back to elastic vs. plastic: in engineering design for safety and durability, we usually care most about the **yield strength** because once a part yields, it's often game over for precision applications – it's bent or permanently deformed. The ultimate strength might be higher, but pushing a material that far means it has already yielded and likely is no longer in functional shape (think of a bent beam – it might not have snapped, but it's not usable). Thus, knowing the yield point from the stress–strain diagram is crucial. Strain hardening is a bonus that gives a margin of safety before fracture (and contributes to toughness), but designs typically don't rely on it (except in processes like cold working intentionally using it to strengthen a part *before* use).

By understanding these concepts, you'll be well-equipped to handle FE exam questions on material behavior. Remember: use Hooke's law in the elastic region, recognize when yield is surpassed, and articulate what strain hardening is doing in the plastic region. Equally importantly, be ready to apply $E = \sigma/\epsilon$ numerically or qualitatively, and identify elastic vs. plastic in any scenario given. Mastery of stress–strain diagrams gives you a strong foundation for many mechanics problems and ensures you won't be caught off guard by questions about why a material behaves the way it does under load.

Topic 03 - Ferrous Metals

Topic Intro: Ferrous metals are iron-based alloys including steels and cast irons – the backbone materials of mechanical engineering. On the FE Mechanical Exam, you can expect questions asking about the phases in steel at various temperatures or carbon contents, the effects of heat treatments (like quenching) on microstructure, and comparisons of different ferrous alloys (e.g. carbon steel vs. stainless steel vs. cast iron). Mastering this topic means you'll recognize **what microstructure forms under what conditions** and how composition affects properties. A typical question might give you a steel with a certain carbon content and cooling process and ask which phases or properties result. Let's break down the essentials so you can tackle these questions with confidence.

K09.T03.S01 – Iron–Iron Carbide (Fe–C) Phase Diagram

Principle Introduction: Understanding the iron–carbon equilibrium phase diagram is key to predicting what phases (solid solutions or compounds) form in steel and cast iron under slow cooling (equilibrium) conditions. Keep these points in mind:

- The Fe–C phase diagram maps temperature vs. carbon content for iron-carbon alloys at equilibrium. It shows where **ferrite (α)**, **austenite (γ)**, **cementite (Fe_3C)**, and mixtures like **pearlite** or **ledeburite** occur.
- Steels (up to ~2.0% C) and cast irons (~2–4% C) are distinguished on this diagram by carbon content. Critical transformation points on the diagram include the **eutectoid** (where a single solid phase transforms to two others) and **eutectic** (liquid transforms to two solid phases) reactions.
- **Ferrite (α)** is BCC iron – soft and ductile, stable at low carbon contents and lower temperatures. **Austenite (γ)** is FCC iron – stable at higher temperatures, can dissolve more carbon. **Cementite (Fe_3C)** is a hard, brittle iron carbide. Most steels at room temperature are a mixture of ferrite and cementite (either as pearlite or dispersed carbides).

Exam Handbook Search Cues (Not affiliated with or endorsed by NCEES): iron–iron carbide, phase diagram, austenite, ferrite, cementite, eutectoid, eutectic (These are keywords you'd use to find relevant info in the exam handbook's materials section.)

Footnotes:

- Ferrite is also called **α-iron** – a BCC form of iron with very limited carbon solubility (~0.02% at 727 °C). Austenite is **γ-iron** – FCC iron that can dissolve up to 2.1% C at 1148 °C. Cementite is the chemical compound **Fe_3C**, often called iron carbide. Each is a distinct phase with unique crystal structure and properties.

- The **eutectoid** reaction in steel (0.76% C) is: *Austenite (γ) → Ferrite (α) + Cementite (Fe_3C)* at 727 °C. The **eutectic** reaction (in cast iron, 4.3% C) is: *Liquid → Austenite (γ) + Cementite (Fe_3C)* at 1148 °C. These transformations define the boundary between steel and cast iron in terms of carbon content.

Variations, Related Forms, Typical Values: For carbon contents *below* the eutectoid (hypoeutectoid steels, <0.76% C), the microstructure after slow cooling is predominantly ferrite with pockets of pearlite – the lower the carbon, the more soft ferrite is present (e.g. a 0.2% C steel might be ~90% ferrite, 10% pearlite). For carbon contents *above* eutectoid but below 2% (hypereutectoid steels, ~0.8–1.5% C), the slow-cooled structure is pearlite plus excess cementite at grain boundaries (making these high-carbon steels inherently harder and more brittle due to the continuous cementite network). At very high carbon (2–4% C, cast irons), the alloy solidifies through the eutectic reaction; cast irons often form a mixture of *ledeburite* (a fine austenite + cementite aggregate from the eutectic) and graphite depending on cooling rate and additives. In practice, most plain carbon steels used in engineering are between 0.05% and 0.8% C, balancing strength and ductility, whereas cast irons (~3% C) are used when good castability and vibration damping are needed.

Explanation & Analysis: The Fe–C phase diagram is essentially the road map for what phases to expect in an iron-carbon alloy at equilibrium. **Why use it?** Because many questions boil down to *"What is the structure of this steel at room temp after cooling?"* or *"At what temperature will this phase appear or transform?"* Knowing this diagram lets you determine if a steel is fully ferritic, fully austenitic, or a mixture at a given temperature. For example, suppose an exam problem gives a steel with 1.0% C and asks what happens as it slowly cools from 800 °C to 600 °C. Using the diagram, you'd see that at 800 °C (above 727 °C) and 1.0% C (hypereutectoid), you have austenite + a bit of cementite. As it passes 727 °C, the austenite transforms into pearlite + more cementite. The result at 600 °C (well below the eutectoid) is pearlite plus cementite. **Phase by phase, term by term:** Ferrite (α) is essentially pure iron with a tiny carbon in solid solution – it's soft (think of it as the "pure iron" phase). Austenite (γ) is a phase where more carbon can dissolve, but it only exists at high temperature – once you cool steel to room temp, austenite will turn into something else (ferrite, pearlite, or martensite) because γ is not stable at low temp unless you're at very high pressures or alloyed in special ways (like in some stainless steels). Cementite (Fe_3C) is a hard intermetallic compound – not malleable at all. Pearlite, as noted, is not a phase but a microstructure of alternating ferrite and cementite lamellae – it's what you get when eutectoid austenite slowly cools. The key to using the diagram is remembering it only applies for **very slow cooling** – that's when the alloy has time to reach equilibrium and form those layered structures or precipitate cementite. If cooling is fast (like quenching), the diagram is "cheated" – the alloy bypasses the ferrite+pearlite path and forms martensite (coming up next). So, use the Fe–C diagram for questions explicitly about equilibrium phases or slow cooling. If the question hints at *rapid cooling* or *hardening*, you might need to think outside the equilibrium diagram, which leads us to... (next subtopic).

K09.T03.S02 – Thermal Treatment of Steel: Martensite vs. Pearlite Formation

Principle Introduction: The way steel is cooled from the austenite phase has a *huge* effect on its final microstructure and properties. This subtopic covers the key heat treatments and transformations:

- **Quenching (rapid cooling):** If you heat steel into the austenite (γ) region and then cool it very quickly (e.g. dunking a red-hot steel part into water or oil), the iron-carbon structure doesn't have time to form equilibrium products (ferrite + cementite). Instead, it "freezes" into a **martensitic** structure. **Martensite** is an extremely hard

and brittle phase of steel formed by this non-equilibrium transformation.

- **Slow cooling (air cool or furnace cool):** Allowing steel to cool slowly (such as in air or in a furnace) gives time for carbon to diffuse. The austenite will transform into **pearlite** (and proeutectoid ferrite or cementite, depending on carbon content) as predicted by the phase diagram. Pearlite is softer and more ductile compared to martensite.
- **Thermal treatments:** Common heat treatments include **annealing** (very slow cool, resulting in coarse pearlite or even graphite in cast irons, for maximum softness), **normalizing** (air cooling, yielding fine pearlite, a bit harder), **quenching** (rapid cool to form martensite, very hard), and **tempering** (reheating a quenched steel to a moderate temperature to reduce brittleness). Thermal treatments are used to tailor mechanical properties for a given application.
- **Phase transformations:** *Austenite → Martensite* occurs when quenching prevents carbon diffusion – the crystal structure changes suddenly (FCC to distorted BCT) trapping carbon in place^[Martensite in steel adopts a **body-centered tetragonal (BCT)** crystal structure – essentially a distorted version of the BCC ferrite structure, stretched by carbon atoms that didn't have time to form carbides. This trapped-carbon structure is responsible for martensite's high internal stress and hardness.]. *Austenite → Pearlite + Ferrite/Cementite* occurs with slow cooling, where carbon can redistribute and form the layered pearlite (ferrite + Fe_3C) structure. An intermediate cooling rate can produce **bainite**, another mixture of ferrite and cementite with a feathery microstructure, but bainite is typically covered in more advanced materials courses – for the FE exam, martensite vs pearlite is the big comparison.*

Definition/Note Passport – *Quenching & Martensite (vs. Pearlite)*:

- **Plain-language definition: Quenching** is the rapid cooling of a hot metal. In steels, quenching from the austenite phase produces **martensite**, a hard and brittle phase, instead of the softer equilibrium mixture (pearlite) that would form with slow cooling. Martensite looks like a needle or plate-like microstructure under the microscope and is super hard (think of a hardened steel file or a glass-hard drill bit). **Pearlite**, by contrast, is the plaid-like mix of ferrite and cementite that forms when austenite cools slowly – it's comparatively softer and more ductile.

- **Where it matters (exam impact):** Expect questions where you need to identify what happens to steel when it's quenched or tempered. For example, *"What microstructure results from rapidly cooling a medium-carbon steel?"* or *"How does quenching affect hardness and ductility?"* The exam might also ask which treatment yields the highest hardness (quenching to martensite) or how to soften a metal (annealing). Recognizing keywords like "rapidly cooled", "quenched", "tempered", "austenitized then water-cooled" will cue you to think of martensite vs pearlite outcomes.

- **Pitfall or confusion point:** A common mistake is to assume **martensite is just another equilibrium phase** – it's not. Martensite is a *metastable phase*, meaning it doesn't appear on the Fe–C phase diagram and it exists because diffusion was suppressed. Also, don't confuse *hardness* with *toughness*: quenching increases hardness **but decreases** toughness (martensitic steel can easily crack if not tempered). Another pitfall is forgetting to **temper** – martensite as-quenched is often too brittle for use, so engineers almost always temper it afterward to regain some toughness.

- **Micro-check (quick test):** *True/False:* Slower cooling of austenite results in more martensite. **(False.)** Martensite only forms with **fast** cooling. Slow cooling gives ferrite/pearlite, not martensite. As a mental check, remember: martensite is like the "emergency brake" microstructure – only appears when you suddenly halt the normal transformation.

Exam Handbook Search Cues (Not affiliated with or endorsed by NCEES): quenching, martensite, pearlite, heat treatment, tempering, phase transformation (These terms will direct you to the steel heat treatment info in the exam reference.)

Footnotes:

- Tempering: After quenching, steel is often **tempered** – heated to a moderate temperature (like 200–600 °C, well below austenite range) and then cooled. Tempering lets some carbon diffuse out of the supersaturated martensite to form tiny carbides, relieving internal stresses [Tempering martensite produces what's called *tempered martensite*, which is basically very fine carbide particles within a ferrite matrix. It's still quite hard but much less brittle. Tempered martensite is the backbone of high-strength low-alloy steels used in things like automotive springs, where you need high hardness *and* some toughness.]. The result: slightly reduced hardness but greatly improved toughness. In exam terms, **quench + temper** yields a strong yet ductile steel, whereas quench alone yields a very hard but brittle steel.

- Not all steels harden equally: **Hardenability** (how deep and easily a steel hardens) is increased by alloying elements like chromium and molybdenum. Plain high-carbon steel can form martensite on the surface when quenched, but in thick sections the core might cool too slowly and end up pearlitic. Alloy steels (like 4340, 8640, etc.) are designed so that even the core cools fast enough (relative to its critical cooling rate) to form martensite. On the FE exam, you generally won't need to calculate hardenability, but qualitatively knowing that *alloy additions improve the ability to through-harden a steel* could explain an answer choice or two.

Variations and Related Terms: Heat treatment isn't just about hard or soft – there are many flavors. **Annealing** is an extreme case of slow cooling (often cooling in the furnace after reaching a high temp) to get the softest possible condition (coarse pearlite, maybe even some spheroidized carbides) – maximum ductility, lowest hardness. **Normalizing** involves air cooling from the austenite region – faster than annealing, so it produces finer pearlite and higher strength than annealed steel, but still much softer than martensite. **Case hardening** (carburizing, nitriding) is a related concept: diffuse carbon or nitrogen into the steel surface and then quench, so you get a hard outer shell (high-carbon martensite) with a tough inner core (low-carbon steel). While case hardening goes beyond just thermal treatment (it's a chemical treatment too), it's good to know as context: it's how you can have, say, a low-carbon steel gear with a wear-resistant high-carbon martensitic surface.

Explanation & Analysis: Let's break down what's happening physically during quenching vs slow cooling, step by step, and why it matters: **Start with austenite:** at high temperature, steel exists as γ (austenite), which is a solid solution of carbon in FCC iron. Now,

Step 1: Cool the steel. If you cool slowly (e.g. 50 °C per hour), Step 2 for a hypoeutectoid steel (<0.76% C) is that it will start forming ferrite as it cools below the A_3 line (the ferrite start boundary). By the time you hit 727 °C, the remaining austenite

transforms into pearlite (layered α+Fe_3C). So final structure: ferrite + pearlite. If it's hypereutectoid (>0.76% C), slow cooling first drops out some cementite network (proeutectoid cementite) as you go below the A_{cm} line, then at 727 °C the rest turns to pearlite. **Result of slow cooling:** a mixture of relatively soft ferrite and harder cementite in a balanced, layered form – good strength and ductility, but not as hard as possible. Now, **contrast with fast cooling (quenching):** Imagine you take that austenitized steel and plunge it into water. The temperature plummets so quickly through 727 °C and far below that the carbon atoms have no time to rearrange into ferrite and carbide layers. Instead, the iron lattice itself **shears** into a new structure (BCT) to accommodate the trapped carbon – that's martensite formation (Step 2 in quenching: diffusionless transformation). Martensite can be thought of as "frozen" austenite – the iron atoms shift into a strained pattern with carbon stuck in between. It's like freezing a liquid so fast that crystals don't have time to form properly – you get a distorted solid. **Result of quenching:** a supersaturated solid solution (martensite) that is extremely hard (can easily exceed Rockwell C 60 hardness, which is file-hard) because the lattice strain resists deformation. But because it's so strained, it has virtually no ductility – it's brittle.

Step 3 (if any): Tempering: By reheating that brittle martensite a bit, we allow those strained iron lattices to relax as tiny carbides precipitate out. The hardness drops maybe 10-20%, but toughness increases dramatically. That's why tempered martensite is usually the desired final state for tools, springs, etc. **Key takeaways:** Use slow cooling (anneal/normalize) when you need a softer, workable metal or to relieve stresses. Use quench & temper when you need high hardness and strength. And from an exam perspective, always link *"rapid cool" → martensite (hard, brittle)* and *"slow cool" → pearlite/ferrite (soft, ductile)* in your mind. If you keep those cause-effect relationships straight, you'll answer heat treatment questions correctly under the pressure of exam day.

K09.T03.S03 – Mechanical Properties of Plain Carbon Steels vs. Alloy Steels

Principle Introduction: The mechanical properties of steel – things like tensile strength, yield strength, hardness, and toughness – depend on composition (carbon content, alloying elements) and heat treatment. In general:

Carbon content effect: Higher carbon in steel means higher potential hardness and strength, but also increased brittleness and lower ductility. Low-carbon steels (e.g. 0.1% C) are very ductile and tough but relatively low strength (think of sheet metal or mild steel bar – it bends before it breaks). High-carbon steels (e.g. 0.8% C and above) can be *very* strong and hard, especially when heat treated, but they are less forgiving (think of a high-carbon spring or a tool – can take a lot of load, but will snap rather than bend when overstressed).

Plain carbon vs alloy steels: *Plain carbon steels* primarily get their properties from carbon content and whatever manganese or silicon is incidentally present. *Alloy steels* contain intentional additions like Cr, Mo, Ni, etc., which don't usually make the steel inherently *stronger* just by being present, but they allow the steel to be heat-treated more effectively (increased hardenability) and can improve properties like toughness, corrosion resistance, or high-temperature strength. Alloy steels can achieve high strengths in thick sections that plain carbon steels cannot, because alloys help to form martensite throughout on quenching and often contribute secondary strengthening mechanisms (like carbide formation, grain refinement, etc.).

Tensile strength vs hardness: Hardness (resistance to indentation) in steel correlates with tensile strength. This is handy: if you know a steel's hardness, you can estimate its ultimate tensile strength. A common approximation (applicable to plain carbon steels) is: an ultimate tensile strength in **MPa ≈ 3.5 × Brinell Hardness Number (BHN)** (or in **psi ≈ 500 × BHN**). So, for example, a steel of hardness 200 BHN will have a tensile strength on the order of 700 MPa (≈100 ksi). This relationship holds because hardness and tensile strength both reflect a metal's resistance to plastic (permanent) deformation.

Typical strength values: Mild low-carbon steel (≈0.2% C, annealed) might have yield strength ~250 MPa and tensile strength ~400 MPa, with a high ductility (>25% elongation). As carbon content and heat treatment are increased, tensile strengths can climb: a medium carbon steel (≈0.4% C) normalized might reach ~600 MPa UTS; a high-carbon steel (≈0.8% C) quenched and tempered can achieve 1200 MPa or more in tensile strength (but only ~1–2% elongation if untempered). Alloy steels like 4140 or 4340, when quenched and tempered, can exceed 1400 MPa UTS while maintaining some toughness – that's why they're used for crankshafts, gears, etc.

Equation Passport – Hardness–Tensile Strength Correlation (for Steel):

Name and purpose: **Brinell Hardness to Tensile Strength Approximation** – provides a quick way to estimate a plain carbon steel's tensile strength from a hardness measurement. This helps to connect lab hardness test results to the material's expected performance in tension.

- **Professional equation (approximate):**

  $$\text{TS (MPa)} \approx 3.5 \times \text{BHN},$$
  $$\text{TS (psi)} \approx 500 \times \text{BHN},$$

  where BHN is the Brinell hardness number of the steel.

Variables and units:

- TS = ultimate tensile strength (MPa or psi)
- BHN = Brinell Hardness Number (dimensionless index from hardness test)
  (The BHN is obtained by pressing a hardened steel ball into the material under a standard load and measuring the indentation size – it's unitless but correlated to material strength.)

Assumptions and scope:

- This correlation holds **for plain carbon and low-alloy steels** in a typical hardness range (e.g. BHN 100–600). It's empirical, so it's not exact, but it's usually within ±10% for those steels.
- It gives **ultimate tensile strength** (not yield strength!). For many steels, yield is lower (except some hardened steels where yield ≈ UTS).
- It shouldn't be applied to non-ferrous metals or high-alloy exotic steels without caution – different materials have different hardness-strength relationships. (For example, this wouldn't hold for aluminum alloys or cast iron the same way.)

Limit tests (sanity checks): If BHN = 0 (an impossibly soft metal), TS would be 0 – trivially, zero hardness means zero strength. If BHN is extremely high, say 600 (approaching the hardness of very hard tool steel), TS (MPa) ≈ 2100 MPa, or TS (psi) ≈ 300,000 psi. Indeed, some of the hardest steels (around 60+ HRC which is ~Brinell 650) can have UTS ~ 2000 MPa, so the formula still holds in that upper range. If you ever got a wildly off value (like predicting 10,000 MPa), you've likely used the wrong units or a material outside scope.

Use vs. sibling equations: Use this **instead of a direct tensile test** when you're given or can measure hardness. On the FE exam, you might not need to calculate with it, but you should recognize it. For instance, if a question says "this steel has a Brinell hardness of 200," you should realize that corresponds to roughly 700 MPa tensile strength (since 3.5×200=700). If a choice says 1500 MPa, that would correspond to BHN ~430, which wouldn't match the given hardness. In contrast, **for other materials** (like brass or aluminum), there are different empirical hardness-to-strength relations; don't use the steel formula for them.

Common exam traps:

- **Unit mix-ups:** Remember 3.5 × BHN gives MPa, and 500 × BHN gives psi. If you accidentally multiply BHN by 3.5 and report it as psi, you'll be off by a factor of ~145! Keep units straight – if the exam provides a hardness and asks for strength in psi, use the 500× factor (or convert after using MPa).
- **Not recognizing the correlation:** It's possible a problem won't hand-hold you – it might just give hardness and ask for strength. If you don't recall the correlation, you might waste time. A quick mental anchor: BHN ~ 200 → ~.2 million psi? That seems too high. Instead, remember **"500×"** is easier: BHN 200 → 100,000 psi (which is ~690 MPa). So memorize either 3.5 or 500 accordingly.
- **Overapplying:** This is for UTS of steel. Don't apply it to calculate yield strength (yield is usually about 0.5–0.8 of UTS for steels, depending on treatment). And don't apply it to a completely different material like cast iron – cast iron's UTS is much lower for a given hardness because it's brittle (it doesn't undergo the same uniform plastic deformation as steel before fracture).

Exam Handbook Search Cues (Not affiliated with or endorsed by NCEES): Brinell hardness, tensile strength, BHN, plain carbon steel, alloy steel, strength vs carbon (These will help you find any reference tables or notes on hardness and strength in the exam handbook.)

Footnotes:

- "Plain carbon steel" typically means iron + carbon with only minor additions (like ~0.5–1% Mn for deoxidation, maybe Si). "Alloy steel" means significant additions of other elements (Cr, Ni, Mo, etc.). For example, 1040 steel (plain carbon, ~0.40% C) vs 4140 steel (an alloy steel with ~0.40% C plus 1% Cr, 0.2% Mo). Both could be hardened, but 4140 will retain hardness deeper in a thick part and often has better toughness after tempering.

- Hardness tests: Brinell (BHN) uses a spherical indenter and gives the BHN number. Rockwell tests (e.g. Rockwell C, HRC) use a diamond cone; there's also approximate conversions (like HRC 20 ≈ 200 BHN, HRC 60 ≈ 650 BHN). The FE exam might mention Rockwell C hardness if discussing extremely hard steels (e.g. "file hardness" ~ HRC 65). The concept remains: higher hardness = higher strength (for the same type of material).

Variations, Related Forms, Typical Values: To give you a feel, here are some **typical values** (not to memorize, but to contextualize): *Annealed low-carbon steel* (~0.2% C) – Hardness ~120 BHN, UTS ~400 MPa, elongation ~30%. *Quenched & tempered medium-carbon steel* (~0.4% C, like 1040 Q&T) – Hardness ~250 BHN, UTS ~800 MPa, elongation ~15%. *Quenched & tempered alloy steel* (e.g. 4340 at 0.4% C with Cr/Mo/Ni, heat treated) – Hardness ~300 BHN, UTS ~1000 MPa, elongation ~12%, but notably, it maintains good toughness at these high strengths (that's the alloy advantage). *Through-hardened high-carbon tool steel* (~0.8% C, with maybe Cr/V, as quenched without much temper) – Hardness ~600 BHN (~ Rockwell C 58–60), UTS ~2100 MPa, elongation < 1% (basically glass-like brittleness, used for things like drill bits, which you don't expect to bend). And for comparison, *Austenitic stainless steel* (304 in annealed condition) – Hardness ~150 BHN, UTS ~600 MPa, elongation ~40% (quite ductile, but can't be hardened by heat treatment, only by cold working). The trend to remember: **more carbon and more martensite = higher hardness and strength, lower ductility**. Alloy additions let you achieve those high strengths in thicker or more complex parts without cracking.

Special Notes – Calculator: If you needed to use the hardness-strength formula in calculations, it's straightforward on any allowed calculator: just a multiplication. For instance, for BHN 180, on a TI-36X you'd do 180 * 3.5 to get 630 MPa (then maybe convert to psi by × 145 if needed). No complex inputs required. Just be careful to use the correct factor for the desired unit system.

Explanation & Analysis: This subtopic is concept-heavy but boils down to understanding trade-offs and being aware of useful correlations.

Why do we care about carbon content? Because in steel, carbon is the primary hardening element – it forms carbides and allows martensite to form. A higher carbon steel can be made much harder (after quenching) than a low-carbon steel. For example, think of a wire coat hanger (very low carbon steel) vs a high-carbon steel piano wire. The coat hanger bends easily (low strength, high ductility) whereas the piano wire is springy and if you bend it too far, it snaps (high strength, low ductility). The difference? Carbon content and heat treatment. On the exam, a question might give you two steels, say 1020 and 1080 (0.20% vs 0.80% carbon) and ask which one can reach a higher hardness after quenching – clearly the 1080. Or it might ask something like "which of the following increases the hardness of steel but also makes it more brittle?" The answer: increasing carbon content (or quenching to form martensite) – both are essentially tied to carbon's effects.

Term by term in our equation: BHN is measured by an indentation test – it's basically telling us how resistant the material is to being permanently deformed. TS is measured by pulling on a tensile test – telling us the maximum stress the material can take. The fact that TS ≈ 3.5×BHN for steel makes intuitive sense: they're both measures of metal strength, just in different forms. The proportionality exists because for steels, the mechanisms that resist indentation (dislocation motion hindered by carbon, etc.) are the same that give high tensile strength.

Carbon vs alloy elements: Carbon is unique in how strongly it boosts hardness; other elements like Cr, Ni, Mo, etc., contribute indirectly. For example, Chromium in stainless steel doesn't make it super strong by itself (actually many stainless steels are a bit weaker in yield than plain carbon steels) – its main role is corrosion

resistance. But in alloy steels intended for strength (not necessarily stainless), elements like Cr and Mo form carbides and delay the austenite-to-pearlite transformation, thus promoting martensite on cooling (higher hardenability). So they **enable** higher hardness throughout the part and often improve *toughness* at a given strength level (because they can refine grain size and such). On an exam question about "plain carbon vs alloy steel," if the context is strength, think: the alloy steel likely can achieve the same strength with less brittleness or can be heat-treated more uniformly. If the context is corrosion or high-temp service, clearly the alloy (stainless or heat-resistant steel) is superior to plain carbon.

Common pitfalls analysis: One trap is to assume "stronger is always better" – e.g., quench everything! But as an engineer, you must consider brittleness; the exam might present a scenario where too high hardness is a problem (risk of cracking), so a softer (lower carbon or tempered) steel is preferable. Also, when comparing materials, watch the units: a strength given in psi might sound huge (~300,000 psi) but that's ~2000 MPa, which is just a very hard steel – so context matters. The hardness correlation helps sanity-check such values. In sum, remember the rule-of-thumb relationships and the qualitative trend: **up carbon, up hardness (and strength), down ductility**. With these in mind, you can infer mechanical behavior of steel in various scenarios quickly and pick the correct answer on the FE exam.

K09.T03.S04 – Common Ferrous Alloys: Carbon Steel, Stainless Steel, Cast Iron

Principle Introduction: Ferrous alloys come in several "flavors" with different compositions and uses. The exam may ask you essentially to distinguish between them by properties or typical applications. The big three to know are:

- **Plain Carbon Steels (and low-alloy steels):** These are iron–carbon alloys with carbon up to ~1% and only small additions of other elements. They're the most widely used engineering metals due to a good balance of strength, ductility, and cost.
- **Stainless Steels:** These are high-alloy steels containing enough chromium (≥ ~11% Cr) to form a protective **chromium oxide film** that greatly resists rusting. They come in various types (austenitic, ferritic, martensitic stainless), but all are known for corrosion resistance.
- **Cast Irons:** These are iron–carbon–silicon alloys with **higher carbon (typically 2–4% C)**. The high carbon plus silicon causes a large portion of the alloy to form graphite or Fe_3C networks. Cast irons are easy to cast into complex shapes and have good compressive strength and vibration damping, but they are generally brittle in tension.

To compare these side-by-side, here's a quick reference table of their composition, key properties, and common uses:
Table: Common Ferrous Alloy Classes – Composition, Properties, and Applications of Carbon Steels vs. Stainless Steels vs. Cast Irons

Ferrous Alloy	Composition (Typical)	Key Properties & Characteristics	Common Applications
Carbon Steel (plain carbon & low-alloy steels)	Iron + ~0.05–1.0% C. Mn ~0.5–1%, Si ~0.2%; low-alloy may have a few % Cr, Ni, Mo (but not stainless level Cr).	*Strength–Ductility Balance:* Can be very ductile (low-C) or quite strong (high-C, especially if hardened). *Not naturally corrosion-resistant:* will rust if unprotected. *Versatile:* Can be welded, machined, and heat-treated (if ≥0.3% C) to modify properties.	Structural beams, plates, and bolted connections (buildings, bridges); shafts, gears (if alloy steel for hardenability); automotive body and engine parts; basically **the go-to material** for general purpose engineering.
Stainless Steel (e.g. 304, 316, 410 types)	Iron + **≥11% Cr**, up to ~0.1% C (for most austenitic grades); often also Ni (~8–10% in 304/316) and possibly Mo (2–3% in 316). Some types (martensitic SS) have higher carbon (~0.4% C) for hardenability.	*Corrosion resistant:* Forms a thin chromium oxide film ("stainless") – dramatically slows rust. *Mechanical properties:* Austenitic SS (300-series) are non-magnetic, tough and formable, moderate strength (~600 MPa UTS). Martensitic/ferritic SS (400-series) are magnetic and can be hardened to higher strength but less corrosion-resistant than 300-series. *High temperature:* Retains strength better than plain steels at elevated temp (and resists scaling).	Chemical and food processing equipment, tanks, and piping (no rust contamination); medical instruments and implants (need sterilization, corrosion resistance); household items (cutlery, sinks – e.g. 18/8 stainless is 304); **whenever corrosion resistance or cleanliness trumps cost**.
Cast Iron (gray, ductile, white, malleable types)	Iron + **2–4% C**, **1–3% Si**. Other elements: often ~0.5% Mn; low residual Mg or Cu added in ductile iron to change graphite shape.	*Castability:* Excellent – melts at lower temp than steel and fills molds well, allowing complex shapes. *Brittle (in many forms):* Gray cast iron contains graphite flakes that initiate cracks – very low tensile ductility (0–1% strain). Ductile iron (with nodular graphite) has improved ductility (maybe 5% strain) but still less than steel. *High compression strength & damping:* Cast irons are strong in compression and the graphite provides vibration damping (gray iron machine bases absorb vibrations). *Hardness:* As cast, can be quite hard in spots (cementite or chilled white iron regions); machinability varies with type (gray iron machines well because graphite flakes free up chips).	Engine blocks and cylinder heads (cast into near-net shape); pipes and fittings (e.g. water mains – cast iron's weight isn't an issue underground and it's pressure resistant); heavy machine structures (bases, frames, where vibration damping is needed); manhole covers, pump housings, cookware (cast iron pans). **Use cast iron when you need a complex shape cast cheaply and can tolerate weight and brittleness**.

How to read & use this table: Each row is a category of ferrous alloy. We list the ballpark chemical makeup (so you know the *ingredients*), then highlight the key properties that define its behavior, and finally typical uses that play to those properties. In an exam context, you'd use this knowledge to, for example, match a described application to the right material: if a question describes a need for "good vibration damping and castability," you'd think *cast iron*; if it says "must be formed into thin sheets and resist corrosion," you'd think *stainless steel (likely austenitic)*; if it says "cheap, high tensile strength needed, can paint to prevent rust," you'd pick *carbon steel*. It also helps prevent mix-ups (e.g., not confusing cast iron with stainless steel!).

Typical exam moves:
- **Identifying alloy from context:** The exam might describe a scenario ("a material used for a building I-beam rusts if not painted, has a yield around 250 MPa, and is very ductile") – that's pointing to a mild carbon steel. Or "a metal that doesn't rust and is non-magnetic but lower yield strength than high-carbon steel" – likely an austenitic stainless. Practice reading the clues: *rusts or not*, *magnetic or not*, *brittle or ductile*, *needs casting vs welding*, etc., to figure out which ferrous alloy fits.
- **Choosing materials for an application:** You could see a question asking which material is best for a certain part: e.g., *"What material is most suitable for a pump housing that must be cast into a complex shape and absorb vibration?"* – The answer would be a gray cast iron (due to excellent castability and damping). Or *"Which of these has the highest ductility?"* – likely a low-carbon steel or an annealed stainless, definitely not a cast iron.

Common pitfalls:

- **Carbon steel vs cast iron confusion:** The dividing line is ~2% carbon. Steels are below that, cast irons above. If you see graphite flakes mentioned, it's cast iron (steel never has graphite, it has cementite if anything; graphite occurs in cast iron due to high C and Si promoting carbon coming out of solution).

- **Stainless steel misconceptions:** Some think "stainless is stronger than regular steel" – not necessarily. Its *superpower is corrosion resistance*, not super strength. In fact, common stainless like 304 is roughly equivalent to a medium-strength carbon steel in strength (and a bit lower yield). Another confusion: not all stainless is non-magnetic – only the austenitic ones (300 series) are essentially non-magnetic; martensitic and ferritic stainless (400 series) *are* magnetic and can be heat treated. The exam might test a trivia like that: e.g., "Which of these is a property of austenitic stainless steel – (A) Magnetic, (B) High carbon content, (C) Excellent corrosion resistance, (D) Very brittle?" The correct answer would be (C) Excellent corrosion resistance (it's non-magnetic and low carbon typically, and not brittle).

- **Assuming cost or weight not relevant:** Remember, cast iron is chosen often because it's cheap and easy to cast – not because it's light or ductile (it's neither). Stainless is chosen despite cost because rust is a killer in some uses. Carbon steel is ubiquitous because it's inexpensive and strong, but it will corrode – in a corrosive environment, using it without protection is a mistake. So match the material to service conditions. The FE won't ask cost explicitly, but they might expect you to eliminate a material that's clearly overkill or unsuitable (like you wouldn't pick stainless for an underground pipe where cast iron's been the industry standard, unless there's a specific corrosion issue).

Exam Handbook Search Cues (Not affiliated with or endorsed by NCEES): stainless steel (for properties like 18-8), cast iron (for types like gray or ductile), carbon steel, alloy steel (Look for any summary tables of material properties in the exam reference if needed – some handbooks list typical yield strengths or composition ranges for these.)

Footnotes:

- The term **"ferrous"** simply means iron-containing. Steel and cast iron are both ferrous alloys (as opposed to non-ferrous like aluminum, copper, etc.). Even stainless steel is ferrous – it's mostly iron – though the high Cr content sets it apart.

- Stainless steel types: **304 stainless** (18% Cr, 8% Ni, ~0.08% C) is the common "18-8" stainless – very corrosion resistant, non-magnetic. **316 stainless** adds ~2% Mo for extra corrosion resistance in chlorides (used in marine environments, surgical implants). **410 or 420 stainless** are martensitic: ~12–14% Cr but with higher carbon (~0.4%); they can be hardened (used in knives, tools) but will rust slightly if not cared for, and they are magnetic. **Cast irons types: Gray iron** has graphite flakes (appears gray on fracture, very common, good machinability, damping, brittle). **Ductile iron** (nodular iron) has graphite as small spheres (added Mg or Ce during casting makes the difference) – much better toughness (can bend a bit before breaking). **White iron** is cooled fast so carbon stays as Fe_3C (no graphite) – it's extremely hard and wear resistant (used in wear-resistant casting parts), but so brittle it's "white" on fracture (no graphite grayness). **Malleable iron** is made by heat treating white iron to convert Fe_3C to clumps of graphite – result is somewhat ductile, hence "malleable."

- A note on **weldability:** High-carbon steels and cast irons are generally *hard to weld* (they can crack on cooling due to hard martensite forming locally). Low-carbon steel is very weldable (one reason it's used in structures). Austenitic stainless is weldable but can crack without proper procedure (and can sensitize to corrosion near welds). This isn't usually tested directly on FE, but it's a practical insight into why certain materials are selected or avoided.

Explanation & Analysis: This final subtopic ties together composition, microstructure, and properties in the context of choosing the right ferrous material. Think of each alloy class as a different **"personality" of iron:**

- **Carbon steel** is the reliable, all-purpose workhorse – strong, not too fancy, but rusts if you don't protect it. If a problem involves something like a building structure or a machine part under load, carbon steel is typically implied unless otherwise stated. Its microstructure in everyday use could be ferrite-pearlite (if not particularly hardened) – giving a mix of strength and ductility. If you need it harder, you can heat treat it (assuming enough carbon is there).

- **Stainless steel** is like iron's upscale cousin – not better in raw strength, but it *doesn't corrode* (and can handle heat). If the scenario is about a chemical plant or food processing or anything where rust is a problem, stainless steals the show. Microstructure-wise, most stainless in practice is austenitic (the 300 series), which is interesting because it retains the γ phase at room temp due to nickel additions – that's why it's non-magnetic and very tough. The exam likely won't quiz you on austenite vs ferrite in stainless, but knowing that stainless's corrosion resistance comes from Cr forming Cr_2O_3 passive layer is worthwhile.

- **Cast iron** is the specialist – great at being cast into complex shapes and sitting there dampening vibrations, but don't expect it to flex or weld or handle tension. If a problem talks about a heavy base or an engine block or something being poured into a mold,

cast iron should come to mind. Its microstructure (for gray iron) is basically ferrite/pearlite plus chunks of graphite flakes. Those graphite flakes are stress concentrators – hence the brittleness, but also they act like built-in lubricant for machining and give the damping properties. Ductile iron's nodules reduce the stress concentration, improving toughness somewhat – perhaps an exam question could mention "nodular cast iron" expecting you to know it's tougher than gray iron. **Bringing it all together:** an FE question on ferrous alloys might not explicitly say "what's the composition of stainless steel" (though it could in a simple form). More likely it will be scenario-based or property-based: e.g., "Which material is best suited for a shaft that must operate in seawater?" (Stainless steel, due to corrosion), or "A material in a rotating bending application is failing in a brittle manner at a relatively low stress, and microstructure shows graphite flakes – what material is this?" (Gray cast iron, which is brittle and has graphite flakes). By studying the comparative traits above, you can quickly eliminate wrong choices. For instance, if one option is "cast iron" and the question demands high ductility, you can toss that out. If another option is "304 stainless" and the scenario is a high-strength tool that doesn't mind rust, you'd know stainless is unnecessary and likely weaker than a quenched-tempered alloy steel for that use. **A final tip:** sometimes the exam may just test terminology: e.g., "Which of these is a ferrous alloy?" Options might include things like brass, aluminum, cast iron, etc. Obviously, cast iron (and steels) are ferrous, whereas brass (copper alloy), aluminum, etc., are non-ferrous. So keep an eye out for that fundamental classification too. In summary, know your steel vs cast iron vs stainless: their composition limits, what sets them apart, and where each shines in engineering applications. That knowledge will let you confidently address any ferrous metal question on the FE Mechanical.

Topic 04 - Nonferrous Metals

Topic Introduction: Nonferrous metals are all metals and alloys that are *not* based on iron. This category includes familiar engineering materials like aluminum, copper, brass (a copper–zinc alloy), magnesium, titanium, and many others. On the FE Mechanical Exam, you can expect questions that test your understanding of how these metals differ from ferrous metals (steels and cast irons) in terms of properties and uses. Typically, you won't be asked to do heavy calculations with nonferrous metal properties; instead, you'll face conceptual questions like choosing the best material for a given application (for example, selecting a lightweight conductor or a corrosion-resistant metal). In short, **Nonferrous Metals** is a topic all about recognizing key properties (density, strength, conductivity, melting point, etc.) and knowing which metals excel in which areas – a vital skill for material selection problems on exam day.

K09.T04.S01 – Properties of Common Nonferrous Metals

Principle Introduction: Key physical properties of common nonferrous metals are summarized below to build your intuition:

- **No Iron Content:** *Nonferrous metals* contain negligible iron. This group includes pure metals like **aluminum**, **copper**, **magnesium**, **titanium**, and alloys like **brass** (copper–zinc) and **bronze** (copper–tin). Because they lack iron, they generally do not rust and are often nonmagnetic [^1].
- **Density Differences:** Many nonferrous metals have lower density than ferrous metals (iron-based). For example, aluminum and magnesium are very lightweight (roughly one-third or less the density of steel), making them ideal when weight savings is critical. By contrast, some nonferrous metals are quite heavy – copper and brass are actually *denser* than steel [^2].
- **Thermal & Electrical Conductivity:** Nonferrous metals tend to excel in conductivity. Copper and aluminum have extremely high **electrical** and **thermal conductivity**, which is why they're used for wires and heat exchangers. Titanium, however, is an outlier – despite being nonferrous, Ti's conductivities are relatively low (closer to stainless steel).
- **Melting Points:** The melting temperatures of nonferrous metals vary over a wide range. Aluminum and magnesium melt at relatively low temperatures (around 600–660 °C), which means they can't withstand the high heat that steel can. Titanium, on the other hand, melts at ~1660 °C (higher than steel), and copper and brass melt around 900–1080 °C. Knowing these orders of magnitude helps in judging where a material can be safely used (for example, you wouldn't use aluminum in a furnace environment).
- **Mechanical Strength & Ductility:** The strength of nonferrous metals spans a broad spectrum. High-performance titanium alloys can achieve tensile strengths comparable to hardened steels (on the order of 800–900 MPa), whereas pure aluminum or magnesium are quite soft (tensile strengths below 100 MPa in their pure form [^3]). Nonferrous metals are often quite **ductile** (able to deform without breaking) – for instance, copper can be drawn into wires easily – although alloying and cold-working can significantly change these properties.

Definition Passport – Nonferrous Metals

- **Definition (plain-language):** *Nonferrous metals* are metals or alloys that do **not** have iron as a primary ingredient. In practice, this term covers essentially all metals except steels and cast irons. Examples include aluminum, copper, nickel, tin, and their alloys (brass, bronze, etc.).
- **Where it matters (exam impact):** Nonferrous metals often appear in exam questions about material selection. You might be asked which material is best suited for a certain condition (e.g. a good electrical conductor, or a lightweight structural material). Recognizing that, say, copper is the best conductor or that aluminum is lightweight is the key.
- **Common pitfalls:** Don't equate *nonferrous* with "lightweight" or "weak" across the board. While many nonferrous metals are lighter than iron/steel and some are softer, there are exceptions. For example, copper and lead are heavy, and titanium can be as strong as alloy steels. Also, *nonferrous* doesn't automatically mean *nonmagnetic* – for instance, **nickel** is nonferrous but is ferromagnetic [^1].
- **Quick micro-check:** *True/False:* Copper and aluminum will not rust like steel does.
  Answer: True (they have no iron, so they can't form rust; instead, they form protective oxides like aluminum's Al_2O_3).

Exam Handbook Search Cues (Not affiliated with or endorsed by NCEES): *Aluminum*, *Copper*, *Magnesium*, *Titanium*, *density*, *conductivity*, *melting point* (These keywords will help you find relevant material properties tables in the exam reference.)

[^1]: *Nonferrous ≠ nonmagnetic:* "Ferrous" means iron-containing. Most ferrous metals are magnetic (iron is ferromagnetic), and many nonferrous metals are nonmagnetic. But some exceptions exist – e.g. **nickel** and **cobalt** contain no iron yet are magnetic. Always use the literal definition: if there's virtually no iron in the composition, it's nonferrous.

[^2]: For context, **steel** (a ferrous metal) has a density around 7850 kg/m³. **Copper** is ~8960 kg/m³ and common brass ~8500 kg/m³, making them heavier (per volume) than steel. In contrast, **aluminum** is ~2700 kg/m³ and **magnesium** ~1740 kg/m³, both much lighter than steel.

[^3]: **Pure vs Alloy Strength:** Pure aluminum (99% Al) has an ultimate tensile strength on the order of 90 MPa – very low. Engineering aluminum alloys (like 6061-T6) are much stronger (~300 MPa), thanks to added elements and heat treatment. Always check if a strength value refers to a pure metal or an alloyed/treated form.

Variations & Typical Values: Nonferrous metals often come in many alloy grades and tempers, which can drastically change their mechanical properties. For example, **aluminum alloys** range from very soft, pure aluminum to high-strength 7000-series alloys used in aircraft. **Brass** alloys can be tuned for higher strength or for better ductility and corrosion resistance by varying the zinc content.

Despite these variations, the fundamental properties (like density or conductivity) tend to stay within the same order of magnitude for a given base metal. It's not necessary to memorize every number, but know typical magnitudes: e.g. aluminum's density ~2.7 g/cc (about one-third of steel's), copper's melting point ~1085 °C (about two-thirds of steel's melting point), etc.

Explanation & Analysis: The properties outlined above distinguish nonferrous metals from the iron-based alloys you might be more familiar with. Let's unpack a few key comparisons:

- **Density (Light vs Heavy):** Aluminum and magnesium stand out for their low weight. This is why they're chosen for applications like aircraft frames or automotive components – cutting weight improves fuel efficiency and handling. On the flip side, copper and its alloys (brass/bronze) are quite heavy. It's a common exam trap to assume "metal = heavy"; be sure to differentiate which metals are lightweight (Al, Mg, Ti) and which are not (Cu, Ni, Pb). Remember that *nonferrous* spans both extremes.

- **Conductivity (High vs Low):** Copper is essentially the gold standard (besides silver) for electrical conductivity – it's set at 100% IACS (International Annealed Copper Standard). Aluminum's electrical conductivity is about 61% that of copper, which is still excellent and comes with much lower weight. Magnesium is around 40% of copper's conductivity, making it a decent conductor but not exceptional. Titanium is very low (a few percent of copper's conductivity), so you wouldn't choose Ti for electrical applications. On the thermal side, the pattern is similar: Cu and Al conduct heat extremely well (think of cookware or heat sinks), whereas Ti and stainless steels are relatively poor heat conductors. If an FE question mentions heat or electrical flow, your mind should go to copper or aluminum as likely answers.

- **Melting Point and Temperature Use:** Nonferrous metals like Al and Mg, with melting points in the few-hundreds °C, cannot be used for high-temperature duties (they'll soften or melt). Titanium's high melting point, however, allows it to work in much hotter environments (and it's a reason titanium is used in jet engines and gas turbines). Copper's melting point (~1085 °C) is relatively high (higher than aluminum's, lower than iron/steel's), which is why you can braze with copper alloys at moderate temperatures. On the exam, you might infer that an aluminum part wouldn't survive in a furnace (true, it'd melt), or that a solder's composition (often tin/lead, both nonferrous metals) is chosen for a low melting point.

- **Mechanical Strength Spectrum:** Nonferrous metals show up in questions about strength-to-weight trade-offs. Pure forms of Al and Mg are very weak (these metals shine in other ways like weight and corrosion resistance), but engineering alloys compensate for this. A typical FE exam question might give you tensile strengths or stress values and ask which material fits – for instance, "Material X has a yield strength ~300 MPa and density ~2.7 g/cm³, what is it likely to be?" The answer would be an aluminum alloy, combining moderate strength with low density. If you see an extremely high strength paired with low weight, titanium alloy might be the match. Conversely, a metal with moderate strength but very high conductivity points to copper. By understanding these property profiles, you can match the material to the description quickly.

- **Corrosion Resistance:** Although not always listed explicitly in property tables, it's worth noting: most nonferrous metals resist *oxidation* (rust) far better than ferrous metals. Aluminum and titanium form thin oxide layers that protect them from further corrosion; copper develops a green patina (copper oxide/carbonate) but doesn't rust through like iron would. Magnesium is a bit of an oddball – it does corrode in wet or salty environments, and often needs a protective coating. On the exam, if corrosion resistance is the key factor, nonferrous options (especially aluminum, brass, or stainless steel if available) will usually be favored over plain steel.

In summary, understanding the **properties of common nonferrous metals** means knowing the relative magnitudes (which metal is heavier, which is stronger, which handles heat, which conducts electricity, etc.) and the qualitative behavior (e.g. "aluminum doesn't rust, is light, and conducts well"). These fundamentals will guide you to the correct choices on material-related questions in the FE Mechanical Exam.

K09.T04.S02 – Typical Uses and Characteristics of Nonferrous Metals

Principle Introduction: Each nonferrous metal has niche areas where it excels. Here are the hallmark characteristics and industrial uses of some major nonferrous metals (and alloys):

- **Aluminum & Its Alloys:** *Characteristics:* Very low density (about 1/3 that of steel) yet decent strength when alloyed, excellent thermal and electrical conductor, and naturally corrosion resistant (thanks to its protective oxide layer). It's also quite ductile, allowing it to be formed into foils and intricate shapes. *Typical Uses:* Aluminum is the go-to metal for weight-sensitive structures – **aircraft and aerospace components**, automobile parts (engine blocks, wheel rims), and even consumer products like laptop frames. Its high thermal conductivity makes it ideal for **heat exchangers, engine radiators, and heatsinks** in electronics. Because it doesn't rust, it's used for **outdoor structures and marine equipment** (though saltwater can still cause some corrosion). Even everyday items – soda cans, aluminum foil – leverage its ductility and non-toxic nature. On the FE exam, think of aluminum whenever the question emphasizes *lightweight* or *good heat/electrical conduction* plus *adequate strength*.

- **Copper & Brasses (Copper Alloys):** *Characteristics:* Copper is heavy (denser than steel) and relatively soft in pure form, but it is *extremely* ductile and the best common electrical conductor (silver is better but expensive). It's also an excellent thermal conductor. Copper's melting point and strength are moderate, but it shines in forming ability (wires, sheets) and resistance to corrosion (it slowly forms a patina but doesn't weaken easily). Brass – an alloy of copper and zinc – has somewhat lower conductivity but higher strength and hardness than pure copper, with excellent machinability and wear resistance. *Typical Uses:* **Electrical wiring and cables** are almost always copper due to its high conductivity and flexibility – expect any electrical application in a question to favor copper. Copper is also

used in **plumbing (pipes, fittings)** because it resists water corrosion and is easy to join. **Heat exchangers** (like HVAC coils) often use copper tubing for efficient heat transfer. Brasses are used for **gears, locks, bearings, valves, and decorative fixtures** – basically anywhere you need a tough, corrosion-resistant metal that's easy to machine (e.g. plumbing valves, musical instruments, bullet casings). On the exam, if you see keywords like *electrical*, *wiring*, or *ductile conductor*, think copper. If you see *machinable*, *corrosion-resistant*, and *not steel*, brass could be the answer.

- **Magnesium & Magnesium Alloys:** *Characteristics:* Magnesium is the lightest structural metal (about 2/3 the density of aluminum). In solid form it has moderate strength but is generally softer and more easily scratched than aluminum. It also has a relatively low melting point (~650 °C) and *must be handled carefully* – magnesium can burn in air if in powder or thin form (it's the metal in old photographic flash powders and emergency fire starters). Mg alloys are usually less ductile than aluminum alloys and can be prone to corrosion (they don't self-passivate as nicely as aluminum). *Typical Uses:* The primary appeal of magnesium is weight reduction. It's used in **aerospace and automotive** components where every gram counts – for example, magnesium-aluminum alloy wheels, gearbox housings, and aircraft engine gearbox components. It's also found in some **electronics (camera bodies, laptop casings)** for lightweight stiffness. However, due to flammability and corrosion concerns, Mg is used where it's either well-protected or in situations where its advantages clearly outweigh the risks. For FE exam purposes, magnesium will be the answer when the question emphasizes *ultra-lightweight* above all else. If a question hints at flammability of metal dust or special fire precautions, magnesium should come to mind as well.

- **Titanium & Titanium Alloys:** *Characteristics:* Titanium has a unique combination: it's about 60% as dense as steel (so heavier than Al, but still much lighter than steel) yet can attain strengths equal to the best steels. It's also famously **corrosion resistant** – it's often impervious to rain, seawater, and even many acids due to a tough TiO_2 oxide layer. Titanium's weakness is cost and difficulty of fabrication (it's hard to machine and weld) and its lower conductivity (thermal and electrical) – Ti does not conduct heat or electricity well relative to most metals. *Typical Uses:* **Aerospace** is a huge domain for titanium: jet engine components, airframe parts, and spacecraft use Ti alloys because they need high strength at high temperatures and corrosion resistance. It's also common in **chemical processing equipment and marine parts** (where steel would corrode, Ti stays inert). Another big use is **biomedical implants** (bone screws, hip replacements) – Ti is biocompatible and strong. On the exam, titanium is your answer when the situation calls for a combination of *high strength, light weight,* and *corrosion resistance*, especially at a high operating temperature. For instance, if a question asks which material is best for a component in a high-temperature, saltwater environment – titanium is a prime candidate.

Exam Handbook Search Cues (Not affiliated with or endorsed by NCEES): *ductility*, *corrosion resistance*, *electrical conductivity*, *lightweight metal uses*, *magnesium* (The exam handbook might not list uses, but these terms link to key properties; e.g. "ductility" definition, or tables listing electrical/thermal properties which hint at usage.)

[^4]: **Brass vs. Bronze:** Both are copper-based alloys (and thus nonferrous). *Brass* is Copper–Zinc and typically has a goldish color; it's known for good machinability and is often used in fittings and bearings. *Bronze* is Copper–Tin (often with other additions) and has a more reddish or brown tone; it generally has high wear resistance (great for bushings) and is known for the "bronze bearings" that can run without lubricant. The FE Exam might mention these in passing; remember both are nonferrous and won't rust, but their properties differ slightly (bronze is usually a bit stronger and more wear-resistant, brass is softer and easier to machine).

[^5]: **Cost factor (FYI):** While not usually tested directly on the FE, it's good to know context – metals like titanium are much more expensive than common metals like steel or aluminum. That's why you only see Ti used in high-performance or specialized roles. If a question scenario involves an everyday application (like building beams or basic tools), you can rule out titanium or exotic alloys for practicality.

Explanation & Analysis: The uses and traits outlined above basically connect each metal's inherent properties to real-world engineering decisions:

- When you see **aluminum** in a problem, think *light, conducts well, can handle moderate loads, won't rust*. Exam questions exploiting this might involve replacing a steel part with aluminum and asking how weight or thermal performance changes. For instance, "if you swap a steel radiator for an aluminum one, what happens?" (Answer: it gets lighter, and heat transfer might improve because Al conducts heat well, but it might not handle as high a temperature if extremes are involved).

- For **copper**, the immediate association is *electricity and heat*. A classic scenario: "Which material is best for electrical wiring?" or "What metal would you use for a heat sink?" – copper (or aluminum) is the obvious choice. If the question involves forming wires or needing extreme ductility (like drawing into a thin wire or deep drawing a sheet), copper's high ductility could be key.

- **Brass** often comes up when a problem hints at needing a combination of good strength with corrosion resistance and easy manufacturability. For example, "What metal for a pump housing that sees water and needs intricate machining?" – brass is a great answer because it doesn't corrode in water and can be cast or machined easily into complex shapes.

- **Magnesium** might appear in a question context where weight is absolutely critical. Suppose a design needs to minimize mass even more than using aluminum – magnesium is one of the few metals lighter than aluminum. An exam question might say, "Material X has to be as light as possible, even if it means sacrificing some strength – which alloy would you pick?" If magnesium alloy is an option, that's the direction. However, they could also test your awareness of its flammability or low melting point with a cautionary tale style question (e.g., why magnesium dust is a hazard in machine shops).

- **Titanium** is likely to feature in scenarios combining harsh conditions: e.g. "structure exposed to seawater", "high-temperature turbine blade", or "biomedical implant" in ethics/biomed context – all are places Ti is used because of its unique property set. On the exam, a question might indirectly describe titanium without naming it, by listing properties: *"Metal Y: density ~4500 kg/m³, very high strength, forms a passive oxide, used in jet engines – identify Metal Y."* They expect you to recognize that as titanium.

The big picture: nonferrous metals fill roles that ferrous metals sometimes can't, due to either lighter weight, better conductivity, or superior corrosion resistance. By linking the *characteristics* (low density, high conductivity, etc.) to *uses* (aerospace, wiring, chemical equipment, etc.), you'll not only answer FE questions correctly but also develop a practical sense for why an engineer would choose one material over another.

K09.T04.S03 – Reference Tables of Nonferrous Metal Properties

Table Passport – Selected Properties of Common Nonferrous Metals
This table provides a quick reference for important properties of four widely-used nonferrous metals and one alloy (brass). It's a comparative snapshot to help you identify the right material under exam pressure.

How to read & use: Each row is a metal (or alloy) with typical values for density, melting point, tensile strength, and electrical conductivity. On the FE Exam, you won't have to memorize these numbers, but you *should* know their ballpark and relative ranking. For example, noticing that titanium's density is higher than aluminum's, or that copper's melting point is greater than aluminum's, can guide you to eliminate wrong choices. If numerical values are needed, the exam will provide them – so treat this table as a way to practice recalling trends. **Do not extrapolate** beyond these: if the exact alloy or condition differs, just remember the general order of magnitude.

Units: Density is given in kilograms per cubic meter (kg/m³). Melting point is in degrees Celsius (°C). Tensile strength is an approximate *ultimate tensile strength* (UTS) in megapascals (MPa) for a typical alloy condition [^6]. Electrical conductivity is listed as a percentage of the International Annealed Copper Standard (% IACS), where 100% = conductivity of pure copper at 20 °C. (For reference, 100% IACS corresponds to about 5.8×10^7 S/m). These values are representative, compiled from engineering data – they are not exact handbook numbers but serve for comparison. All values are at room temperature unless otherwise noted.

Typical exam moves:

- **Identify by property:** Use the table to match a description to the correct metal. E.g., a question might describe a "light metal, melting around 660 °C" – you'd recognize that as aluminum. Or "a metal with ~900 MPa strength and great corrosion resistance" – that's titanium alloy.

- **Compare options:** If an exam question gives you multiple materials to choose from, compare their densities or melting points against the requirements. For instance, if something must operate at 500 °C, magnesium (melts at ~650 °C) might be too close for comfort, whereas titanium would be fine.

- **Eliminate implausible answers:** Knowing orders of magnitude helps avoid silly mistakes. If asked which metal piece will weigh more, you won't mistake aluminum for being heavier than copper. If asked which material might fail in a hot environment, you'll know low-melting aluminum or magnesium are suspects before high-melting copper or titanium.

Common pitfalls:

- **Unit mix-ups:** Remember that 1 g/cm³ = 1000 kg/m³. A student who memorizes aluminum's density as "2.7" (in g/cm³) might mis-handle it if the calculation needs kg/m³. In our table, aluminum is ~2700 kg/m³, which is the same as 2.7 g/cc [^7].

- **Overlooking strength vs weight:** Sometimes examinees incorrectly assume a stronger material is always heavier. Titanium blows that up – it's both strong *and* relatively light. Don't fall into the trap of "light = weak" or "heavy = strong" without evidence.

- **Assuming all nonferrous are high conductivity:** Titanium and some alloys have low conductivity. If a question answer choice says "titanium for electrical bus bars" or similar, that should raise a flag – use copper or aluminum for conduction tasks, not Ti.

- **Rust vs corrosion:** Students know nonferrous metals don't rust (rust is iron oxide), but that doesn't mean they can't corrode. Magnesium, for example, *will* corrode (forming white oxides) and even aluminum can suffer galvanic corrosion or pitting in saltwater. So if a question asks about corrosion in seawater, the best answers might be titanium or bronze, not magnesium, even though Mg is nonferrous.

Now, study the table below for a concise property comparison:

Metal/Alloy	Density (kg/m³)	Melting Point (°C)	Tensile Strength (MPa)	Electrical Conductivity (% IACS)
Aluminum (Al alloy)	≈ 2,700	660	≈ 300 (typical alloy)	~60%
Copper (Cu)	≈ 8,960	1,085	≈ 220 (pure annealed)	100% (baseline)
Brass (70% Cu, 30% Zn)	≈ 8,500	~920	≈ 300 (annealed)	~28%
Magnesium (Mg alloy)	≈ 1,740	650	≈ 200 (typical alloy)	~40%
Titanium (Ti–6Al–4V)	≈ 4,500	1,660	≈ 900 (heat-treated)	~3%

Special Notes: When using a calculator for any material property calculations, ensure consistency of units. For example, if you're computing weight = density × volume, convert volume to m³ if using density in kg/m³. Also, if you ever need to compute electrical

resistance of a wire on the exam (a rare but possible scenario linking materials to circuits), remember the formula $R = \frac{\rho \ell}{A}$ (resistivity times length over area) – materials like copper have low resistivity ρ, so they give low R. If a question gives you a resistivity value in units like 1.7×10^{-8} Ω·m (which is copper's ballpark), you'll recognize the material as a very good conductor.

[^6]: **Tensile strength values:** The MPa values in the table are representative of common engineering conditions (not the absolute maximum possible). For instance, **Ti–6Al–4V** can reach ~900 MPa (or more) with heat treatment – that's a typical high-grade titanium alloy strength. **Brass** (70/30 cartridge brass) around 300 MPa is for an annealed state; cold-work could push it higher. These numbers are for context; the exam will usually state any specific values needed in a problem.
[^7]: **Density units sanity check:** Water's density is 1000 kg/m³ (which is 1.0 g/cm³). So aluminum at 2700 kg/m³ is 2.7 times heavier than water by volume. This can help sanity-check your understanding: if a metal had *density = 0.5 g/cm³*, that would be 500 kg/m³ – lighter than water, which almost no solid metal is (lithium and some metal foams aside). Using water as a reference (1.0 g/cc) is a quick way to keep perspective on density values.

Explanation & Analysis: The reference table reinforces many points discussed earlier with concrete values. Let's analyze a few comparisons:

- **Al vs. Steel (ferrous baseline):** Notice aluminum's density ~2700 vs steel's ~7850 kg/m³ – that ~1/3 ratio is why aluminum dramatically lowers weight. But its tensile strength here (~300 MPa) is less than a typical steel (which might be 400–600 MPa). This means an aluminum part often needs to be thicker or differently designed to handle the same load as a smaller steel part. The exam could indirectly test that concept by asking, for example, how an aluminum beam's cross-section might compare to a steel beam's for the same load.

- **Copper vs. Aluminum (the conductor showdown):** Copper is about 3.3 times as dense as aluminum and has a higher melting point. Electrical conductivity: copper is the 100% benchmark, and aluminum ~60%. In practice, aluminum wires are used in power lines because they are much lighter (weight is critical for overhead cables) even though they carry somewhat less current per cross-section than copper. An exam question might present a scenario about wiring material: if weight or cost is the issue, aluminum might be picked over copper, but for maximum conductivity in a small space, copper wins.

- **Brass vs. Copper:** Notice that brass is included in the table to show how adding other elements (like zinc) can trade off conductivity for strength. Brass has similar density to copper (since zinc's density is close to copper's), but its conductivity is much lower (~28% of copper) because the alloying electrons scatter more. However, brass's tensile strength ~300 MPa can exceed that of pure copper (~220 MPa for annealed, though cold-worked copper can also approach 300 MPa). This exemplifies alloy design: sacrificing some electrical performance to gain mechanical strength and hardness. FE questions might not delve into numeric differences between brass and copper, but qualitatively, know that *brass is harder/stronger and still corrosion-resistant, but not as conductive as pure copper*.

- **Magnesium vs. Aluminum:** The table shows magnesium as the lightest (1740 kg/m³) – about 64% of aluminum's density. The tensile strength shown (~200 MPa) is lower than aluminum's typical 300 MPa. So, per volume, Mg alloys hold less load than Al alloys but weigh ~1/3 less. For highly weight-sensitive designs with lower stress requirements, Mg can outperform Al (like a lightly loaded housing where weight is premium). But if you push magnesium too hard, it might fail where aluminum wouldn't. The exam could reflect this in a question about material selection for a lightweight part: if strength isn't critical, magnesium might be best; otherwise, aluminum might be safer.

- **Titanium vs. Others:** Titanium's density (~4500 kg/m³) sits between aluminum and steel, but its tensile strength is way up at ~900 MPa in alloy form. That combination (strength ~3× aluminum's at ~1.7× the weight) gives it a superior **specific strength** (strength-to-weight ratio) – one reason it's used in aerospace. Also note its tiny 3% IACS conductivity – essentially, Ti is a poor conductor, so you'd never use it for electrical parts if alternatives exist. If an FE problem lists titanium alongside others, consider what's being asked: if it's about strength in a corrosive/hot environment, Ti likely stands out as the right answer; if it's about electrical or thermal conduction, Ti is the wrong answer. And if cost or availability is hinted, Ti might be ruled out in favor of cheaper metals like aluminum or steel.

By internalizing the data from this table, you equip yourself to *think on your feet* during the exam. Instead of memorizing exact numbers, focus on relationships: which metal is lighter, which is stronger, which handles heat, which conducts electricity, etc. Those relationships often spell the difference between a right and wrong choice on the FE. You can always refer to the exam's reference handbook for specific values, but having the trends in your memory will save precious time. In summary, **nonferrous metals** as a topic ties together material science basics with practical application – and the FE exam will expect you to pivot from raw data (like a table of properties) to sound engineering judgments (like picking the appropriate material) seamlessly.

Topic 05 - Engineered Materials

Topic Introduction – Engineered Materials: In the realm of materials science, *engineered materials* refer to advanced classes of materials like composites, polymers, and ceramics that are tailored for superior or specific properties. This topic is crucial for the **FE Mechanical Exam** because many questions require understanding which material is suitable for a given application or how to compute an effective property of a composite. Typical question archetypes include identifying material categories (e.g. thermoplastic vs thermoset), comparing properties (like which material is brittle or has a high strength-to-weight ratio), or calculating a composite's effective modulus or density given constituent data. Mastering this topic means you can quickly recall key properties (strength, weight, ductility, temperature resistance) and apply simple mixture rules – a valuable skill on exam day for any material selection or property estimation problems.

K09.T05.S01 – Composite Materials: Fiber-Reinforced Composites

Principle Introduction: Fiber-reinforced composites combine two or more distinct materials to leverage their best properties. They typically consist of:

- **Reinforcing fibers** (e.g. carbon, glass, or aramid fibers) that are very strong and stiff for their weight.
- **Matrix material** (often a polymer resin or metal/ceramic matrix) that binds the fibers, transfers load between fibers, and provides shape and toughness.

This combination yields a material with **high strength-to-weight ratio** (exceptionally strong for its mass) and often high stiffness-to-weight as well. Composites can be **anisotropic** – they exhibit different properties in different directions (e.g. much stronger/stiffer along the fiber direction than across it). Key advantages include customizable properties (by choosing fiber type, orientation, and volume fraction) and often superior specific strength compared to traditional metals. A common exam scenario is computing effective composite properties using the rule of mixtures or recognizing that a composite can replace a metal when weight savings are critical.

Equation Passport – Rule of Mixtures (Axial Loading) – computes effective properties of a continuous fiber composite (e.g. density or modulus) from the properties of its constituents and their volume fractions (assuming load is applied along the fiber direction, so all components experience the same strain):

- **Density of a composite:** When components are mixed without voids, the overall density is the volume-fraction-weighted sum of component densities. For a two-component composite (fiber f and matrix m):

$$\rho_c = f_f \rho_f + f_m \rho_m ,$$

where f_f and f_m are the volume fractions (decimal form) of fiber and matrix, and $f_f + f_m = 1$. (For multiple components, extend the summation $\rho_c = \sum_i f_i \rho_i$.)

- **Young's modulus (axial):** If fibers are aligned with the loading (**iso-strain condition**), the composite's axial modulus is also a volume-fraction-weighted sum of moduli:

$$E_c = f_f E_f + f_m E_m ,$$

meaning the composite is as stiff as the sum of each component's stiffness contribution. Each component carries load in proportion to its stiffness and volume fraction under equal strain.

Variables and Units:

- ρ_c = composite density (kg/m³)
- ρ_f, ρ_m = density of fiber and matrix, respectively (kg/m³)
- E_c = composite Young's modulus in fiber direction (Pa or GPa)
- E_f, E_m = Young's modulus of fiber and matrix (Pa or GPa)
- f_f, f_m = volume fraction of fiber and matrix (dimensionless fractions, e.g. 0.6 and 0.4)

Assumptions and Scope:

- **Uniform strain (axial loading):** These formulas assume the fibers and matrix deform together (strain is equal in both) – true for continuous, unidirectional fibers under tension/compression along their length (a common design for high-performance composites). The materials must be well bonded so load is shared. *Scope:* This is the **parallel (iso-strain) rule of mixtures**. It applies to properties like density, and for mechanical stiffness or strength when load is along aligned fibers.
- **Linearity:** Assumes linear-elastic behavior (valid for computing modulus). Also assumes no significant voids or defects (volume fractions sum to 1).
- **Two-phase composite:** We typically consider one type of fiber in one matrix. If multiple fiber types or fillers are present, each can be included in the summation with its own volume fraction and property.

Limit Checks (sanity tests): If the fiber fraction $f_f \to 0$ (i.e. almost no fibers, all matrix), then $E_c \to E_m$ and $\rho_c \to \rho_m$; the composite reverts to matrix properties – which makes sense. If $f_f \to 1$ (fiber dominates), then $E_c \to E_f$ and $\rho_c \to \rho_f$; the composite approaches the fiber's properties. The composite's properties will always lie between the extremes of its constituents. A quick check: if you accidentally used weight fractions instead of volume fractions in these formulas, the results would not obey these sensible limits, so always convert to volume basis.

Use vs. Related Equations: Use this *parallel rule-of-mixtures* for properties along the fiber direction (or any case where components all carry strain together). **Do not confuse it with the series (iso-stress) rule-of-mixtures** – in a scenario where components are stacked or loaded in series (all feeling the same stress), the effective modulus would follow $\frac{1}{E_c} = \frac{f_f}{E_f} + \frac{f_m}{E_m}$ (harmonic mixture). That *inverse sum* formula is appropriate for loading perpendicular to fiber orientation (e.g. load trying to stretch the composite transversely, where fiber and matrix strains differ). On the FE exam, if not explicitly stated, assume fibers carry load along their

length (use the formula above) unless the question setup clearly indicates otherwise.

Common Exam Traps:

- **Mixing up fractions:** Confusing volume fraction with weight fraction is a classic mistake. The rule-of-mixtures formulas use **volume fractions**. If a problem gives percentages by weight, you'd need to convert to volume fractions before using these equations[^1].
- **Unit consistency:** Ensure modulus and density units are consistent when plugging values (e.g. don't mix GPa with Pa without conversion). Volume fractions should be input as decimals (e.g. 60% → 0.60).
- **Fiber direction matters:** Using the axial formula for a situation where load is perpendicular to fibers will over-predict stiffness. Remember that a composite is much less stiff or strong across the fibers. If a question subtly hints the load is transverse (or the fibers are randomly oriented), the simple sum $E_c = \sum f_i E_i$ might not apply.
- **Ignoring matrix contribution:** While fibers often dominate strength/stiffness, do include the matrix portion in calculations. For example, if fiber fraction is small, the matrix significantly affects E_c. Don't assume $E_c \approx E_f$ unless fiber fraction is very high.

Exam Handbook Search Cues (Not affiliated with or endorsed by NCEES): *composite, volume fraction, rule of mixtures, fiber modulus* (These are keywords one might search in the exam's on-screen reference to find composite material formulas or guidance.)

Footnotes:

[^1]: **Volume vs. Weight Fraction:** *Volume fraction* f_i is used because mechanical properties like modulus scale with the physical volume share of each material. Weight (mass) fraction would misrepresent contributions if densities differ. For example, heavy fibers with a given weight% actually occupy smaller volume%, carrying less of the strain field than weight% alone suggests. Always convert to volume fraction when using mixture rules.

Variations and Related Concepts: Aside from axial stiffness and density, other properties can be estimated with similar linear mixtures if the loading condition justifies it. **Thermal properties:** heat capacity per unit volume $C_c = f_f C_f + f_m C_m$ (assuming thermal equilibrium and uniform temperature change) and coefficient of thermal expansion (if both materials expand together) can be averaged by volume fraction as well. **Specific strength** (strength-to-weight ratio) is a key figure of merit for composites: specific strength $= \frac{\sigma_{\text{ult}}}{\rho}$. Fiber composites often have extremely high specific strength – for instance, carbon fiber reinforced plastic can have a specific strength several times that of steel, because the composite is both strong and light. **Strength parallel to fibers:** is often dominated by fiber strength. A rough rule-of-mixtures can estimate it (similar form $\sigma_{\parallel} \approx f_f\, \sigma_f + f_m\, \sigma_m$), but in practice the weaker component (often the matrix or the fiber-matrix bond) limits the ultimate strength. On the exam, you're more likely to use given data directly (e.g. failing at fiber stress or using a provided tensile strength for the composite) rather than derive strength from first principles. Also, note there are other types of composites (particle-reinforced, laminates, etc.), but fiber-reinforced is the most common context in mechanical applications.

Special Notes: No complex calculations beyond basic arithmetic are typically needed for these formulas – they're straightforward weighted averages. They are calculator-friendly: just multiply each property by its fraction and sum. Make sure your calculator is in normal mode (not doing something weird with percentages or fractions). If dealing with percentages, convert them to decimals before multiplication.

Explanation & Analysis: A composite material, in essence, is **an engineered blend**: by combining a high-performance fiber with a supporting matrix, engineers achieve a material that is lighter than metals yet can rival (or exceed) their strength. On the FE Exam, you might encounter a question like: *"Given a fiberglass composite with 70% glass fibers (E = 72 GPa) in a polymer matrix (E = 3 GPa), what is the approximate Young's modulus of the composite along the fiber direction?"* You'd simply do $E_c = 0.70(72) + 0.30(3)$ in GPa to get the answer (~50 GPa in this case). The principle behind this is that under axial load, both fiber and matrix stretch the same percent (equal strain), so the stiffer fiber bears a proportionally larger share of the load. The formula effectively averages stiffness by how much volume each material occupies.

Let's break down the axial modulus formula term by term: $E_c = f_f E_f + f_m E_m$. Here f_f (volume fraction of fiber) is a pure number like 0.70, and E_f is the Young's modulus of the fiber, say 72 GPa (a unit of pressure, 10^9 N/m²). Multiplying f_f by E_f gives the fiber's contribution to the composite stiffness (in the same units of pressure). Likewise $f_m E_m$ is the matrix's contribution. The sum E_c will have units of pressure as well (GPa), and it will always end up between E_m and E_f. Physically, if the matrix is much softer, most of the strain energy is taken up by the matrix, but the fibers still add significant stiffness if present in large fraction. Conversely, if the fiber is extremely stiff and occupies a good chunk of volume, the composite will be much stiffer than the pure matrix. **Common pitfalls:** forgetting to use volume fractions (as noted) or plugging in fractions like 70 as if it were 0.70 (one needs to move the decimal!). Also, remember that the rule-of-mixtures is *not* a magic universal law – it works best for properties that average over volume and for loading configurations where each material's share of deformation is proportional to its length/volume in that direction. For off-axis or complex loading, the exam will likely either guide you to a different approach or stick to qualitative questions.

In summary, fiber-reinforced composites are all about **tailored performance**. They let us put strength and stiffness exactly where we want it (along fibers) while keeping weight low. On exam day, when you see a question about a new lightweight material or combined materials, think "composite" and apply these straightforward mixture rules or property comparisons. With a clear head and the rule-of-mixtures in your toolkit, these questions can be some of the quickest points you'll earn.

K09.T05.S02 – Polymer Materials: Thermoplastics vs. Thermosets

Principle Introduction: Polymers (plastics) are engineering materials made of long molecular chains. They come in two broad categories with distinct behaviors:

- **Thermoplastics:** Plastics that soften and melt upon heating and can be remolded repeatedly. They consist of separate, entangled polymer chains (linear or branched) with no permanent crosslinks between them.
- **Thermosets:** Plastics that, once cured (hardened through chemical reaction or heat), cannot be remelted. They have a crosslinked, networked structure (think of it as all chains chemically bonded into one giant molecule). When heated excessively, thermosets do **not** melt; instead, they degrade or char.

These differences lead to **typical mechanical property contrasts**: Thermoplastics are often *ductile or flexible* (they can undergo significant deformation before breaking) but generally have lower strength and lower service temperature limits. Thermosets, by contrast, tend to be *rigid and sometimes more brittle* (little deformation before fracture) but can handle higher temperatures without losing shape (until they eventually burn or crack).

Understanding these categories matters for exam questions on material selection (e.g. which type of polymer suits a high-temperature application or which can be reshaped) and on recognizing stress-strain behavior of materials (a thermoplastic might show a yielding behavior, whereas a thermoset might snap without yield).

Table Passport – Thermoplastics vs. Thermosets:
The table below compares key properties and behaviors of thermoplastic and thermoset polymers. Use it to decide which polymer type is implied in exam scenarios and to avoid mix-ups between them.

Property/Behavior	**Thermoplastics** (e.g. Polyethylene, Nylon)	**Thermosets** (e.g. Epoxy resin, Vulcanized rubber)
Reprocessing (when heated)	*Melt-remoldable:* Soften or melt when heated; can be reshaped multiple times. Useful for recycling and injection molding.	*Permanently set:* Do not melt upon reheating (will degrade/char instead); **cannot** be reshaped once cured.
Molecular Structure	Long polymer chains with *no permanent crosslinks*. Chains can slide past each other when heated (causing flow). Often either amorphous or semi-crystalline structures.	Highly *crosslinked network* of polymer chains (chemical bonds linking chains into a rigid 3D structure). Crosslinks prevent flow; the material retains shape until thermal decomposition.
Mechanical Behavior	Generally **more ductile** or flexible. Lower Young's modulus and hardness compared to thermosets. Can exhibit significant plastic deformation (think of a plastic milk jug bending).	Generally **stiffer and more brittle**. Higher Young's modulus and hardness. Little plastic deformation – tends to fracture suddenly when stress limits are exceeded (think of a hardened epoxy cracking). Some thermosets (elastomers) are very stretchy, but they are a special case (see footnote).
Temperature Sensitivity	**Low to moderate service temperatures:** Has a definite melting point or softening range. At elevated temperatures, loses strength rapidly (think of a plastic cup warping with heat). Many thermoplastics also have a **glass transition temperature (Tg)** below which they become hard and glassy and above which they are rubbery.	**High thermal stability:** No true melting point (decomposes at extreme temp). Can often withstand higher operating temperatures without losing rigidity (e.g. thermoset composites in engines). Thermosets typically only have a glass transition (if any) above which they soften slightly, but they will break down chemically if overheated.
Common Applications	Molded parts, films, and consumer plastics that may need reshaping or welding. Examples: polyethylene (PE) bottles, polypropylene containers, ABS plastic lego bricks (all thermoplastics). Easy to recycle (can be melted and reused).	Durable, high-strength components, adhesives, coatings. Examples: epoxy glue, polyester fiberglass resin, vulcanized rubber (tires). Often chosen for heat-resistant and structural applications. Not recyclable by melting (though rubber can be ground and reused as filler).

Exam Handbook Search Cues (Not affiliated with or endorsed by NCEES): *polymers, thermoplastic, thermoset, glass transition, crosslinked* (Use these terms in the exam reference to find information on polymer classifications and properties.)

Footnotes:

- *Glass Transition (Tg):* The temperature at which an amorphous polymer (or the amorphous portions of a semi-crystalline polymer) changes from a brittle, glassy state to a softer, rubbery, more flexible state. **Thermoplastics** often have a Tg (e.g. PVC's Tg ≈ 80°C) and, if partly crystalline, a higher melting point Tm. **Thermosets** often only exhibit a Tg (above which they may soften or lose some stiffness) since they do not melt. Knowing whether a polymer operates above or below its Tg is crucial: below Tg it will be hard and potentially brittle; above Tg it's softer (rubbery for thermoplastics, or possibly just less stiff for thermosets).
- *Elastomers:* A special subset of polymers (often lightly crosslinked, thus technically thermosets) that exhibit extreme elasticity. **Rubber** is the prime example: it's a thermoset (vulcanized rubber has crosslinks) but behaves very elastically (able to stretch and recover). Don't let the presence of crosslinks confuse you – elastomers are thermosets that are designed to be very flexible. The exam may mention "rubber" or "elastomer" as having high elasticity and large elongation at break, distinguishing it from a brittle thermoset like a phenolic resin.

Variations and Related Forms: Polymers can also be classified by structure (amorphous vs. semi-crystalline) which affects their transparency and how sharply they melt. **Amorphous thermoplastics** (like acrylic or polystyrene) soften over a range of temperature and are often transparent; **semi-crystalline thermoplastics** (like polyethylene or nylon) have a more defined melting point and are often opaque and tougher. Mechanical properties vary widely: some thermoplastics (e.g. polycarbonate) are actually quite strong and tough, and some thermosets (like certain epoxies) can be formulated to be less brittle, but the general trends hold. Also, **composites vs. pure polymers:** Often thermoset polymers are used as the matrix in fiber composites (for example, carbon fiber reinforced epoxy). In that case, the polymer by itself might be brittle, but combined with fiber it forms a composite with excellent strength and toughness.

Special Notes (calculator usage): There are usually no direct calculations with big formulas for polymer questions – they are mostly conceptual or involve basic comparisons. However, be prepared to interpret a polymer stress-strain graph or temperature-dependent behavior. For example, if given a graph of modulus vs. temperature, you should recognize the drop at Tg. If a numerical problem arises (like thermal expansion or something), use the standard formulas (e.g. thermal strain $\Delta L = \alpha L \Delta T$ if needed – polymers often have higher thermal expansion coefficients than metals). These formulas are straightforward to input. The key is knowing which values to plug in; the exam handbook provides typical properties if needed, but usually the problem statement will give any specific polymer data required.

Explanation & Analysis: Thermoplastics vs. Thermosets is essentially a question of *reversibility* and *structure*. On the FE Exam, you might see a question like: *"Which type of polymer would you choose for a part that might need to be reshaped or recycled?"* The answer would be a **thermoplastic**, because you can melt and reform it. Conversely, *"Which polymer type is better for high-temperature operation (like an engine component)?"* – likely a **thermoset**, because it won't melt at elevated temperatures (it might be an epoxy or silicone that can handle the heat).

Breaking down their behaviors: **Thermoplastics** soften as you heat them – think of butter or wax (not polymers, but as analogies) that melt upon heating and solidify upon cooling. Microscopically, heat gives the polymer chains mobility to slide apart. This is why thermoplastics are great for processes like injection molding or 3D printing; you can repeatedly melt pellets and solidify them into shapes. Mechanically, many thermoplastics exhibit yielding – for example, a piece of polyethylene will stretch (plastic deformation) before it finally tears, showing ductility. In contrast, **thermosets** are set hard by curing (often an irreversible chemical reaction that forms lots of crosslinks). Once set, the chains can't move independently – it's like a three-dimensional web. Heat will not let the chains flow; instead, excessive heat breaks the bonds (so the material might discolor or burn, but not melt into a puddle). This makes thermosets dimensionally stable at elevated temperatures. For instance, a cured epoxy holding electronic components won't melt if the device heats up a bit; a thermoplastic in that situation might soften and fail. Mechanically, because of the rigid network, thermosets often behave elastically and then fracture – imagine trying to bend a hard epoxy casting; it just snaps.

For the exam, remember **key distinguishing features**: If the question mentions the ability to *reshape or recycle*, think thermoplastic. If it mentions *high heat, rigidity, or two-part resin* (like an epoxy adhesive you mix and cure), that's a thermoset. Also recall that polymer properties are very temperature-sensitive. A polymer's modulus (stiffness) typically drops by an order of magnitude or more when you go above its Tg. So a thermoplastic that is tough at room temperature might become floppy on a hot day if its Tg is near that temperature. A classic conceptual question could be: *"Why might a polycarbonate (thermoplastic) safety glass become brittle in a freezer?*" – Answer: because at low temperature it goes below Tg and behaves like a glassy, brittle material.

In summary, polymers can be tailored as needed: choose thermoplastics for versatility and reshaping, or thermosets for strength and thermal stability. Knowing the differences helps you avoid choosing the wrong material in a design scenario and will help you eliminate wrong answer choices on the FE exam. Keep these characteristics in mind, and polymer questions should be very approachable.

K09.T05.S03 – Other Advanced Materials: Ceramics and Their Properties

Principle Introduction: Ceramics are a class of inorganic, non-metallic materials (often compounds of a metal and oxygen, nitrogen, or carbon, such as oxides, nitrides, carbides). They are known for a combination of extreme properties: **very high hardness and compressive strength, excellent high-temperature stability, chemical inertness, and brittleness (lack of ductility).** In practical terms, ceramics can withstand forces in compression (squeezing) and high heat that would deform or melt metals, but they will crack or shatter under tension or impact because they cannot plastically deform to absorb those stresses. These general properties make ceramics ideal for certain applications (like cutting tools, engine parts, or electrical insulators) and pose challenges in others (they require careful design to avoid tensile stresses). On the FE Exam, you may encounter ceramics in questions about material selection (e.g. which material out of a list is brittle or suited for a high-temperature furnace lining) or in conceptual questions about stress-strain behavior (a brittle stress-strain curve vs a ductile one). Understanding the key traits of ceramics ensures you can quickly identify when a problem is hinting at using or avoiding a ceramic material.

Definition Passport – Ceramics (Brittle, High-Strength Materials): A **ceramic** is an engineered material typically made from metallic and nonmetallic elements bonded together (often ionic or covalent bonds) and characterized by hardness, high melting point, and brittleness.

- **Where it matters (exam impact):** Ceramics show up in questions about material properties and failure modes. For example, you might be asked which material from a list has virtually *no yielding* (ceramics do not yield before breaking), or which material retains strength at red-hot temperatures (ceramics can, metals generally can't without losing strength). They also appear in context of coatings or insulating materials due to their heat and wear resistance.
- **Key Properties to remember: Brittle** (no significant plastic deformation – they fracture suddenly), **high compressive strength** (can support very large compression loads, much higher than their tensile strength), **low tensile strength** relative to compressive (they fracture under much smaller tension loads), **high hardness** (resist scratching or wear – think of the hardness of porcelain or silicon carbide abrasives), and **thermal stability** (many ceramics tolerate very high temperatures without melting or deforming; e.g. alumina ceramic melts above 2000°C, way above most metals). Many ceramics are also **electrical insulators** and have low thermal conductivity (used in insulation), though some specialized ceramics (like silicon carbide) can conduct heat well while still being electrically insulating.
- **Pitfall or confusion point:** Don't confuse *strength* with *toughness*. Ceramics can have extremely high **compressive strength** and decent **ultimate strength** in an absolute sense, but they are not *tough* because they lack ductility – meaning any small flaw can initiate a crack and cause failure suddenly. Students often misunderstand "strong" as always good – but a strong and brittle material can be disastrous if used where flex or impact occurs. Also, unlike metals, ceramics do not have a yield point; their stress–strain curve is essentially linear up until fracture. That means no warning before failure, which is a key design concern.

- **Micro-check (quick self-test):** *True or False:* "A ceramic rod will stretch significantly (show noticeable elongation) before it breaks under tensile load." → **False.** In tension, a ceramic will fracture at a relatively low strain (often well under 0.5% elongation), with almost no plastic stretch.

Exam Handbook Search Cues (Not affiliated with or endorsed by NCEES): *ceramic, brittle, compressive, high-temperature, hardness* (These terms help find references to ceramic properties in the exam reference material.)

Footnotes:

- *Design Safety Note:* Engineers use **large safety factors** or **compressive-only designs** with ceramics. For example, concrete (a ceramic composite) is always placed such that it primarily experiences compression. If a ceramic must bear tension, designers account for its **fracture toughness** (a measure of crack propagation resistance) and often implement conservative stress limits. Remember: tensile strength of ceramics is typically an order of magnitude (or more) lower than compressive strength. This disparity is due to micro-cracks: under tension they open and cause failure early, under compression they tend to close and are less harmful.

- *Examples of ceramics:* Common engineering ceramics include **Alumina (Al_2O_3)** – used in electrical insulators and cutting tool inserts; **Silicon Carbide (SiC)** and **Tungsten Carbide (WC)** – extremely hard ceramics used in abrasives and cutting tools; **Silicon Nitride** – used in high-performance ball bearings and engine parts for its strength at high temperatures; and **Glass** (amorphous silica) – technically a ceramic, used in windows and fiberglass, also brittle. Remember that even though glass is weaker than some crystalline ceramics, it shares the fundamental brittle behavior (it breaks without plastic deformation).

Variations and Typical Values: Ceramics cover a broad family, including **traditional ceramics** (like brick, porcelain) and **advanced ceramics** (engineered for high performance). While numbers aren't usually needed on the exam, it's illustrative to know ranges: A typical high-strength ceramic might have a compressive strength of 2000–5000 MPa, but a tensile strength of only 50–300 MPa. Compare that to a steel, which might have ~500–1000 MPa in both tension and compression before yielding. Also, ceramics often have **density** in the 2–3 g/cc range (similar to aluminum or lighter), which combined with their strength gives them high specific strength in compression. **Thermal expansion** of ceramics is generally lower than metals (they don't expand as much when heated, which is good for thermal shock resistance in some cases), but their **thermal shock tolerance** depends on both expansion and their low toughness (rapid temperature changes can crack a ceramic). **Ceramic-matrix composites** (CMCs) are a variation where a ceramic is reinforced with fibers (often also ceramic fibers) to improve toughness – those are advanced materials used in extremely high-temperature environments (beyond metals or polymer composites). While CMCs are probably beyond FE exam scope, it's good to be aware that engineers do have strategies to overcome ceramic brittleness when needed.

Special Notes: You won't have to calculate complex equations for ceramics on the FE exam; it's more about recognizing their behavior. However, be comfortable with the idea of **brittle fracture**. If the exam question involves an *impact test* or *fracture toughness*, a ceramic will perform poorly compared to a metal – for example, Charpy impact test values for ceramics are much lower (they absorb little energy). If any formula appears, it might be something like using **Hooke's Law** $\sigma = E\epsilon$ in the elastic range, since ceramics are linear elastic until break. Just remember that once σ exceeds the breaking strength, there's no yield term – failure is immediate.

Explanation & Analysis: Ceramics stand out because they're **hard as a rock** (indeed, rock/concrete is a ceramic) and **heat-proof** in ways metals and polymers aren't. On the FE exam, a classic identification question might be: *"Which of the following materials is most suitable for the high-temperature interior lining of a furnace?"* – The correct choice would be a ceramic (like refractory brick), due to its ability to handle intense heat without melting, whereas metals would soften and polymers would burn. Another example: *"A material that exhibits no yielding and shatters suddenly when loaded in tension is likely to be…?"* – The answer: a brittle material like a ceramic (or glass).

Analyzing ceramic behavior: On a stress–strain curve, a ceramic would have a steep linear portion (high slope = high Young's modulus, similar or higher than metals), and then an abrupt end at fracture. No yield plateau, no necking – just elastic and break. If you think of stretching a ceramic rod, it might extend only a tiny bit (a fraction of a millimeter per meter of length) before cracking. In contrast, a ductile metal would stretch noticeably and give you warning (yielding). The reason lies in atomic bonding: ceramics are held by strong ionic/covalent bonds which don't allow atomic planes to slip past each other easily. That's why they are hard and elastic (resist shape change), but also why when the stress is too high, they break (the bonds rupture rather than slide). Also, any small defect in a ceramic acts as a crack starter – and with no ductility, the crack zooms through the material (brittle fracture).

In compression, however, those same micro-cracks don't spread as easily because the material is being squeezed, not pulled apart. So ceramics can sustain astonishing compressive loads. For example, a concrete column (concrete is a ceramic composite) can hold up a skyscraper, but if you pull on a concrete rod, it might snap under a load that a steel rod of the same size would handle easily.

For exam purposes, remember these contrasts: **Metals vs. Ceramics:** metals yield, ceramics don't; metals are tougher (can absorb energy by plastic deformation), ceramics are harder (resist surface deformation but fail suddenly); metals lose strength at high temperature (think of softening red-hot steel), ceramics retain strength far into the red-hot range (they're used in kilns and rocket engines). **Polymers vs. Ceramics:** polymers are much softer (low modulus, low strength) and can be very ductile (like chewing gum) or can also be brittle if below Tg, but even brittle polymers can often elongate a bit more than ceramics and certainly can't take the heat ceramics can.

When faced with a problem, look for keywords: *brittle, ceramic, glass, high-temp, compressive vs tensile strength*. These signal that the concept of ceramic behavior is in play. The exam might not require you to recall numeric values for ceramic properties, but you should know the *trends*: highest melting points (ceramics), highest hardness (ceramics), poor tensile performance (ceramics). If a question involves a material that needs to not deform under load and temperature but where weight isn't a big concern, ceramics are likely candidates. Conversely, if a design needs to absorb impact or tension, a pure ceramic is a red flag unless somehow reinforced.

In conclusion, ceramics are like the **strong-but-brittle heroes** of materials engineering – unbeatable in harsh conditions and heavy compression, but they need to be handled with care in design due to their sudden failure mode. Keep their key properties in mind, and

you'll crack (no pun intended) any exam question about them without any fractures in your confidence.

Topic 06 - Manufacturing Processes

Topic Introduction: Manufacturing processes are how raw metals are transformed into useful engineering components. This topic is important for the **FE Mechanical Exam** because it connects how a part is made to the material properties it will have. Typical exam questions will ask you to identify the appropriate process for a given task (for example, casting vs. forging) or to predict how a process (like cold-working or heat treating) will change a metal's strength or ductility. In other words, you'll need to know both *what* each process does (practically) and *how* it affects the material (metallurgically) on exam day.

K09.T06.S01 – Overview of Manufacturing Processes for Metals

Principle Introduction (Background Theory):
- Metals can be shaped and joined through various manufacturing processes, each with distinct methods and outcomes. Knowing these processes helps in selecting the right one for cost, geometry, and material performance considerations.
- **Primary categories** include: **casting** (pouring liquid metal into molds), **forming** (deforming solid metal into shape, such as rolling, forging, extrusion), **machining** (cutting material away), and **joining** (combining pieces by welding, brazing, etc.).
- The choice of process affects not only the final shape but also the metal's **mechanical properties**. For example, forging a part can improve its toughness (refining the internal grain structure), whereas casting can create complex shapes but may contain internal porosity. On the FE exam, expect questions that describe a scenario and require you to recall which manufacturing process fits best or what the trade-offs are.

Table: Primary Metal Manufacturing Processes and Key Characteristics

Process	Description & Key Features
Casting	*Method:* Metal is melted and poured into a shaped mold, then solidified in place. *Effect/Use:* Can produce very complex shapes (even internal cavities) in one step. Cast parts may have internal defects (shrinkage voids, porosity) and generally have **lower strength** and toughness compared to wrought (worked) metal due to coarse as-cast structure. Best for intricate or large shapes that would be difficult to make by other means.
Rolling (Forming)	*Method:* Metal is passed through rollers to reduce thickness (for sheets) or to shape cross-sections (for beams, rails, etc.). Often done hot for large reductions (hot rolling) or cold for finishing (cold rolling). *Effect/Use:* Efficiently produces uniform sheets or structural shapes. Hot rolling refines cast structure and relieves segregation, resulting in improved ductility and toughness (but oxide scale forms, rough finish). Cold rolling (a form of cold-working) increases strength and produces a smooth finish, but introduces residual stress and reduces ductility.
Forging (Forming)	*Method:* Metal is shaped by compressive forces, often with hammering or pressing between dies. Frequently performed hot (heated to make the metal malleable). *Effect/Use:* Produces very strong parts with aligned grain flow (the metal's internal grain structure "flows" into the shape of the part). Forged components (like crankshafts, wrenches) have **superior mechanical properties** (higher strength and toughness) compared to cast, because forging closes up voids and refines the microstructure. Typically used for critical high-strength parts.
Extrusion (Forming)	*Method:* A hot billet of metal is forced through a die opening, emerging as a long piece with constant cross-section (like pushing Play-Doh through a shape). Can also be done cold for softer metals. *Effect/Use:* Great for making uniform cross-sectional products like rods, tubes, and complex profiles (e.g. aluminum window frames). Hot extrusion allows large deformation of even strong metals by reducing flow stress, yielding a worked structure with improved properties over casting.
Machining	*Method:* Material is removed from a workpiece via cutting tools (e.g. turning on a lathe, milling, drilling). It's a **subtractive process** as opposed to shaping by deformation. *Effect/Use:* Achieves **high accuracy and smooth finish**. Can create precise dimensions, holes, and features that casting or forming alone cannot. Almost any metal can be machined, but it produces scrap (waste) and can be time-consuming. Machining doesn't fundamentally change the metal's internal structure like forming does, except for possible surface work-hardening.
Welding (Joining)	*Method:* Two pieces of metal are joined by melting their edges (often adding filler metal) so that they fuse into one continuous piece upon cooling. Many techniques exist (arc welding, gas welding, etc.), generally involving intense localized heat. *Effect/Use:* Creates a **permanent, high-strength joint** (ideally as strong as the base metal). However, the metal in the weld and heat-affected zone cools from high temperature, which can leave residual stresses or a cast-like microstructure. Often followed by post-weld heat treatment to relieve stress for critical applications.
Brazing (Joining)	*Method:* Two metal parts are joined by melting a separate filler metal that flows into the joint by capillary action. The base metals are **not melted** (unlike welding). Brazing is typically done at a lower temperature than welding (but still fairly hot; filler alloys like bronze or silver-based alloys melt above ~450 °C). *Effect/Use:* Can join dissimilar metals and delicate or thin parts with less thermal distortion than welding. The joint strength is generally **less than a weld** (since the bond is through the filler metal), but often stronger than a soldered joint. Used in things like HVAC coils, carbide tool tips, and electronic assemblies (at higher temps than soldering).

How to read this table: Each row outlines a distinct manufacturing process for metals, including how it's carried out and what it means for the part's properties and uses. Understanding these differences helps you quickly decide which process a problem is referring to, or which process would be suitable for a described task. There are **no units** in this table since we're describing processes qualitatively.

- **Typical exam moves:** You might get a question describing a scenario like "a complex one-piece aluminum housing with internal cavities needs to be made" or "a steel rod needs to have extremely high strength." You should be able to pick the correct process: in the first case *casting* is a good candidate, in the second case perhaps *forging* (or *cold drawing*, a form of forming). Other questions might ask, for example, what process is characterized by not melting the base metal (expecting "brazing"), or which process aligns grain flow with the part shape (expecting "forging"). The exam may also simply list processes and ask which one typically produces the strongest parts, etc. This table is your quick reference for those kinds of comparisons.
- **Common pitfalls:** A common mistake is to **mix up similar processes**. For instance, don't confuse *brazing* with *welding* – remember that welding melts the base metal, brazing does not. Similarly, distinguish *casting* (liquid metal) from *forging* (solid-state deformation) – students sometimes erroneously think cast metal is "stronger" because it was liquid (actually the opposite: forged is stronger due to working). Also, be mindful of terminology: *forming* is a broad category (which includes rolling, forging, extrusion, etc.), and many forming processes can be done either hot or cold depending on the metal and desired outcome. Keep track of which processes strengthen the material (usually those involving cold work or certain heat treatments) and which might require a secondary treatment to improve properties (welds often need stress relief, castings might be followed by heat treat or hot isostatic pressing in industry, though that's beyond exam scope). In short, know the unique hallmark of each process.

Exam Handbook Search Cues (Not affiliated with or endorsed by NCEES): casting; rolling; forging; extrusion; machining; welding; brazing

Footnotes:

- *Forming processes like forging and rolling are often performed at elevated temperature (hot working) to reduce the force required and avoid cracking. Cold forming is possible for softer metals or smaller deformations, but extensive cold work may require intermediate anneals.*

- *Brazing vs. soldering:* Brazing is essentially high-temperature soldering. In **soldering**, a filler metal (like tin-lead solder) melts at a lower temperature (typically below 450 °C) to join parts, often for electronics or plumbing. Both brazing and soldering do not melt the base metals – they rely on the filler metal to bond the pieces. Brazing uses higher-temp filler alloys and yields stronger joints than soldering, but both are weaker than a true weld.

Micro-check: *True or False – A forged steel crankshaft will generally be tougher and stronger than a cast steel crankshaft made from the same alloy.* (Think about grain flow and internal defects when answering this.)

K09.T06.S02 – Thermal and Mechanical Processing of Metals (Cold-Working vs. Hot-Working)

Principle Introduction (Background Theory):

- Mechanical deformation of metals can be done under different temperature conditions. **Cold-working** means shaping the metal at roughly room temperature (or at least below the metal's recrystallization temperature), whereas **hot-working** means deforming the metal at a high temperature (above the recrystallization threshold). These two approaches have dramatically different effects on the metal's properties.

- **Cold-working** (cold-forming) increases a metal's strength and hardness at the cost of ductility. By deforming the metal at low temperature, you introduce a tangle of dislocations (crystalline defects) that make further deformation harder – the metal becomes **strain-hardened**. For example, if you hammer or roll a steel bar at room temp, it will get stronger but also more brittle as you continue to work it.

- **Hot-working**, on the other hand, is done at high temperatures where the metal's crystal structure can continuously recover and recrystallize during the process. As you deform the hot metal, new strain-free grains form and replace the work-hardened ones. The result: the metal stays **soft and ductile** even though it's being heavily deformed. A blacksmith forging iron while it's red-hot is a classic example – the metal can be hammered into a new shape without cracking because it doesn't accumulate strengthening defects; they're annealed out immediately by the heat.
- An everyday illustration: bending a paperclip back and forth at room temperature (cold work) makes it harder and then it breaks – that's cold-work embrittlement. But if you could somehow heat the paperclip while bending it (not practical for plastic-coated office clips, but in industrial processes it is), it would be more like molding clay – you could deform it a lot without it breaking, because it remains softer (that's hot working). In summary, cold-working strengthens but embrittles, hot-working stays ductile but does not create strengthening. Knowing which scenario applies in a problem will guide how the material's yield strength and ductility have changed (or not).

Equation Passport: *Percent Cold Work* – quantifies the degree of plastic deformation by area reduction, used to measure how much cold-working a metal has undergone.

Name and purpose: Percent Cold Work (%CW) – calculates the percentage reduction in a metal's cross-sectional area during deformation. It's a measure of how heavily a metal was cold-worked. A higher %CW means more plastic deformation (greater work hardening) was imposed.

Formulation:

$$\%CW = \frac{A_0 - A_d}{A_0} \times 100\%$$

where the areas refer to the cross-section before and after deformation.

Variables:

- A_0 – initial cross-sectional area of the metal (m²)

- A_d – cross-sectional area after deformation (m²)
  (The difference $A_0 - A_d$ is the area reduction. If dealing with thickness reduction (for sheet metal) and width remains constant, you can use thickness in place of area proportionally. Always use consistent units for area.)

Assumptions:

- The metal's volume remains essentially constant during plastic deformation (a valid assumption since metals are nearly incompressible in solid state). This is why area reduction correlates to thickness reduction inversely – as cross-sectional area decreases, length increases, keeping volume roughly the same.
- The deformation is uniform across the cross-section. %CW is most accurate when the entire cross-section is reduced evenly (as in drawing out a wire or rolling a sheet). Localized deformation would not be captured by a simple area ratio.
- *Scope:* Used primarily for ductile metal working processes like rolling, drawing, etc., under cold-working conditions. It's a quick way to quantify "how much" cold work was done, which correlates with increased strength and decreased ductility.

Limit checks (sanity tests):

- If no deformation happened, then $A_d = A_0$. Plugging that in: %CW = $\left((A_0 - A_0)/A_0\right) \times 100\% = 0\%$. No surprise – zero cold work, zero strengthening.
- If the final area A_d is much smaller than the original A_0 (a heavy draw or reduction, like drawing a thick rod into a thin wire), then $(A_0 - A_d) \approx A_0$ and %CW approaches 100%. You can't actually reach 100% cold work unless the area goes to zero (which is impossible in practice), but very high percentages (e.g. 80% cold reduction) indicate an extreme amount of deformation. At such high cold work, metals often need annealing because they become very brittle.

Use vs. related metrics:

- Use %CW to quantify cold-working instead of just an elongation or strain value when dealing with significant area change. For instance, drawing wire or rolling sheet changes area; % reduction in area is a more direct measure of work input than linear strain in such cases.
- A related concept is **strain (ε)** in tensile deformation: for a rod in simple tension, a certain elongation corresponds to area reduction via Poisson's ratio. But %CW is more general for processes like rolling/drawing where the shape change isn't a simple uniaxial stretch. It captures the cumulative work hardening effect.
- Also, note that **hardness increase** or **strength increase** in a cold-worked metal often correlates with %CW. For example, a copper wire drawn to 50% area reduction will be significantly harder than one drawn 10%. There isn't a simple universal formula relating %CW to strength for all materials (each alloy has its own hardening curve), but qualitatively more cold work = higher yield strength.

Common exam traps:

- **Mixing up A_0 and A_d:** It's easy to accidentally invert the formula. Remember it's initial minus final over initial. If you plug it in reversed, you'd get a negative percentage (which would be non-sensical in this context). Keep track: A_0 is larger for a reduction process, so $A_0 - A_d$ should be positive.
- **Using linear dimensions instead of area:** If a problem gives diameter or thickness change, don't just take percentage of diameter – convert to cross-sectional area percentage. For instance, reducing a wire's diameter by 50% actually reduces the cross-sectional area by **75%** (since area $\propto d^2$). The exam may test whether you know to square the change if needed. If width is constant, you can simplify %CW as thickness reduction percentage, but generally think in terms of area.

Confusing cold work with "cold" temperature service: Here "cold" refers to processing temperature relative to recrystallization, not that the metal is icy cold. A metal could be "cold-worked" at what seems like a warm temperature (hundreds of degrees) if its recrystallization temperature is higher. Likewise, "hot-working" often means red or orange hot for steel, but for a metal like lead, room temperature is above its recrystallization point – so lead can be effectively hot-worked even without heating. Always interpret cold vs. hot **relative to recrystallization temp**, not ambient temperature alone.

Exam Handbook Search Cues (Not affiliated with or endorsed by NCEES): cold working; hot working; recrystallization; recovery; grain growth

Footnotes:

- *Recrystallization temperature:* roughly **0.4–0.6 T_m** (40–60% of the metal's melting point, on an absolute temperature scale) for a given metal. Above this temperature, the metal can recrystallize (form new grains) during or after deformation. **Hot-working** is defined as deforming the metal at or above this recrystallization threshold. **Cold-working** is below it. (For example, most steels have a recrystallization temperature around 600 °C or higher, so room temperature deformation is definitely cold-working. Pure lead, by contrast, recrystallizes at or below room temperature, so simply hammering lead at room temp doesn't work-harden it much – it's effectively hot-worked under ambient conditions.)

- *Strain hardening:* another term for the effect of cold work – the phenomenon where a metal *hardens* (increases in yield strength) due to plastic deformation. This is caused by dislocation generation and entanglement in the crystal structure. On a stress–strain diagram, a cold-worked metal will have a higher yield stress and tensile strength, but usually a lower ductility (strain to failure) than the same metal in an annealed (pre-cold-work) state.

Explanation & Analysis: When approaching FE exam problems about metal processing, first **identify whether the scenario is cold-working or hot-working** – it changes how you think about the material's properties afterwards. Cold-working is essentially *deformation + strengthening*. The classic case is something like: "A copper rod is drawn through a die to reduce its diameter" or "a steel plate is cold-rolled." In such cases, you should immediately recall that the yield strength and hardness will increase, but the metal will become less ductile (more brittle) due to strain hardening. Cold-worked metals also retain residual stresses and

might have anisotropic properties (properties differ along different directions, because of aligned grain deformation). If a question asks, for example, "What is the effect of cold rolling on a metal's yield strength and ductility?" the correct understanding is **strength goes up, ductility goes down**.

Hot-working, in contrast, is *deformation + recovery*. If an exam question says a part was "hot-forged" or "hot-rolled," you should infer that the metal did **not** get the benefit of work hardening – because any dislocations introduced were continuously eliminated by recrystallization. The metal will have a fresh, strain-free grain structure after processing. In fact, hot-working often produces a fine, equiaxed grain structure that can be quite tough. The key advantages of hot-working are: you can achieve large shape changes (because the material stays soft and doesn't harden as you go), and you eliminate any prior cold-work effects (if the metal was previously hardened, hot-working will reset it to a softer state). The disadvantage is that the final part comes out in a relatively **annealed condition** (softer, lower strength unless subsequently treated). It may also have surface oxidation or decarburization from the high temperatures.

In terms of **FE exam applications**, be prepared for conceptual questions. You might see a question like: *"A metal has been cold-worked significantly. What subsequent process can restore its ductility?"* The answer there would be **annealing** (a heat treatment to soften, which we'll cover next) – but the setup is understanding that cold work took away ductility. Another example: *"Compared to hot forging, cold forging of a part will result in what differences in the part's properties?"* You'd answer something along the lines of: cold forging results in higher strength/hardness (due to strain hardening) but lower ductility, whereas hot forging leaves the part softer (though it could have improved toughness and a refined grain from recrystallization).

It's also useful to recognize that many manufacturing sequences use a combination: for instance, **hot-working for big shape changes**, then **cold-working for final sizing and property tuning**. A metal sheet might be hot-rolled from an ingot to a rough thickness, then cold-rolled at the end to get the desired final gauge and a harder condition. This combination yields good final properties and precision. If you encounter a question where a part is processed in multiple steps (say hot forged then cold finished), consider the effects of each step in turn.

From a microstructural standpoint, you can think of cold-working as stuffing more and more defects into the metal's structure – like piling up traffic in a city grid; things slow down (dislocations can't move easily, so the metal resists deformation more – it's stronger). Hot-working is like periodically clearing the traffic by opening new streets (new grains) and healing the damage; the metal doesn't accumulate the resistance to deformation, so it stays more pliable. Just remember: **cold = stronger/harder but brittle, hot = softer but ductile.** And if a question involves calculating % cold work or given initial vs. final dimensions, use the Percent Cold Work formula to quantify it. Always double-check units (convert diameters to areas if needed) and sign (percent cold work should come out positive). With these concepts mastered, you won't be caught off guard by any "cold vs hot processing" questions on the exam.

Micro-check: *Does hot-working a metal generally produce any significant strengthening of the material?* (Think about what happens to dislocations at elevated temperatures before you answer.)

K09.T06.S03 – Heat Treating Processes: Annealing, Normalizing, Quenching, Tempering

Principle Introduction (Background Theory):

- Not all material property changes come from deforming the metal; many are achieved by purely thermal means. **Heat treating** is the use of controlled heating and cooling cycles to alter a metal's internal structure (microstructure) and thus change its properties. Importantly, **heat treatments do not usually change the shape of the part** – the metal is just being heated and cooled, not plastically deformed (though thermal expansion/contraction happens). This makes heat treatment a powerful tool: after a part is in a certain shape, you can still modify how hard or soft it is by how you heat or cool it.

- For the FE Mechanical Exam, the key heat treatment processes to know are **annealing**, **normalizing**, **quenching**, and **tempering**, especially as they apply to steel. Each of these refers to a specific kind of thermal cycle and leads to a characteristic change in microstructure and mechanical properties.

- Broadly: **annealing** and **normalizing** involve heating a metal and then cooling it slowly (annealing very slowly, normalizing a bit faster in air) to make it softer or refine its structure. These are essentially *softening* treatments – they generally **increase ductility and relieve stresses** (at the expense of some strength). In contrast, **quenching** involves rapid cooling from a high temperature to harden the metal (for steels, quenching creates a very hard but brittle phase called martensite). **Tempering** is usually a follow-up step after quenching, where you reheat a quenched metal to a moderate temperature and then cool it, to **reduce brittleness** and get a more balanced strength-toughness profile.

- The classic scenario is with steel: heat it up to make austenite (a high-temperature phase), then cool it in different ways. Cool it slow (anneal) and you get soft ferrite-pearlite structure. Cool it medium (normalize) and you get finer pearlite, a bit harder. Cool it fast (quench) and you trap martensite, super hard but brittle. Then heat that quenched steel a bit (temper) and you toughen it up by letting the martensite relax a little. Each process has a purpose, and exam questions often ask "what is the purpose of tempering?" or "what heat treatment could soften a cold-worked metal?" etc. Let's break down each process.

Table: Common Heat Treatment Processes (for Steel) and Their Effects

Process	How it's Done & What it Does to the Metal
Annealing	**Method:** Heat the metal to a high temperature, then cool **very slowly** (often by switching off the furnace and letting the metal cool inside it). For steel, this usually means heating into the single-phase austenite region then furnace-cooling. **Effect:** The metal becomes **soft, ductile, and stress-free**. Slow cooling gives the structure time to reach equilibrium – in steel you get coarse pearlite (and ferrite if applicable) which is a very soft microstructure. Internal residual stresses are relieved. Annealing essentially resets the metal to its **lowest strength, highest ductility** state (great if you plan to cold-work it further or need it to be machinable).
Normalizing	**Method:** Similar to full annealing, but the cooling is done in air (cooling in still air is faster than furnace-cooling but not as rapid as quenching). Steel is heated to make austenite then removed from the furnace to air-cool. **Effect:** The metal **strengthens moderately** compared to annealing because the faster cool produces a finer microstructure (for example, fine pearlite in steel). Normalizing still removes internal stresses and homogenizes the structure, but the resulting hardness is a bit higher than an annealed piece. It's often used after forging or welding to **refine grain size** and produce a more uniform, tougher structure. (Normalized steel is harder and stronger than annealed steel, but still has good ductility.)
Quenching	**Method:** Heat the metal to a high temperature and then cool it **rapidly** in a quenching medium. Common quench mediums are water, oil, or even air for certain alloys – water is very fast (severe quench), oil is slower (milder quench). For steel, heating to the austenite phase and then quenching can prevent the usual transformation to pearlite/ferro-carbide; instead it **traps a hard, metastable structure** known as **martensite**. **Effect:** The metal becomes **very hard and high-strength**, but also **very brittle** in the as-quenched state. Quenching introduces a lot of internal stress (due to the rapid change and phase transformation). In steels, as-quenched martensite can be so brittle that a sharp blow might crack it – that's why quenching is almost always followed by tempering. (Quenching in non-steel alloys can also harden them if there are phase changes or to freeze in a solution treatment, but steel's martensitic quench is the prime example.)
Tempering	**Method:** After quenching a steel, reheat it to a moderate temperature (well below the critical temperature where austenite would form – often in the range of 150 °C to 600 °C, depending on desired result), hold it at that temperature for some time, then cool (usually in air). **Effect:** Tempering **reduces the hardness slightly but dramatically increases the toughness** of quenched steel. It works by allowing some of the martensite to transform into more stable forms (like ferrite plus fine carbide precipitates), relieving the stresses and brittleness. Essentially, tempering **trades a bit of strength/hardness for a lot more ductility**. The higher the tempering temperature (and/or longer time), the softer and tougher the steel will get (up to a point). Tempered martensite is still harder than pearlite, but not as brittle as untempered martensite. *Analogy:* Quenching makes the steel glass-hard, tempering gives it some "give" so it's usable in applications.

How to read this table: Each row describes a heat treatment process, explaining **how it is performed** and the **resulting effect on the metal's microstructure and properties**. We focus on steel examples because those are common on the exam (steel has well-defined phases like austenite, pearlite, martensite, etc.), but the general ideas carry to other alloys. There are no numerical units here, just qualitative descriptions. Pay attention to the cooling rate differences and the keywords like "soft," "hard," "brittle," "tough," for each process – these are your clues in exam questions.

Typical exam moves: Expect questions asking *"Which process is used to soften a metal after it's been work-hardened?"* (Answer: annealing, because it restores ductility). Or *"What is the purpose of tempering after quenching a steel?"* (Answer: to reduce brittleness and increase toughness). You might also see a question like *"A steel is heated to austenite and air-cooled. What is this process and its effect?"* (That's normalizing – producing a fine-pearlite structure, increasing strength compared to annealed). Another classic question format: *"Which of these microstructures is produced by quenching medium-carbon steel?"* and they list martensite, pearlite, etc. – the correct answer being **martensite** for a fast quench. Essentially, know the *before-and-after* for each treatment: what phase or structure you start with, and what you end up with.

Common pitfalls: One trap is **confusing the terms**. For instance, don't mix up *annealing* with *tempering* – both involve heating and slowish cooling, but annealing is a one-step process to soften (from any condition, often after cold work), whereas tempering specifically comes after a quench to draw back hardness. Another pitfall is forgetting that **tempering requires a prior quench**: you can't temper something that hasn't been hardened first; if you "temper" an already soft steel, you're just gently heating it – nothing much changes because there were no martensite stresses to relieve. Also, note the difference between *normalizing vs. annealing* – both start with full heating, but normalizing's faster cooling makes it harder. Students sometimes think normalizing and annealing are interchangeable – in exam context, normalizing implies air cooling and a moderately harder result.

Another subtle point: **quench media and severity** – water quench is faster than oil, which is faster than air. Extremely rapid quench (like water) can cause more distortion or cracking due to thermal stress, but achieves maximum hardness. The FE exam usually won't ask you to choose a medium, but understanding that "quenching" might be qualified by how severe (fast) it is could be useful if a question explains a part cracked on quenching – the concept being that a slower quench (oil or an interrupted quench) can mitigate that. However, in most cases, just recognize "quench = fast cool = hard/brittle" in general.

Finally, avoid thinking that these treatments magically change the chemical composition – they don't. They rearrange the existing structure. So if a question mentions high carbon steel quenched and tempered vs low carbon steel quenched, recall that high carbon steel can form martensite and harden significantly, whereas very low carbon steel might not harden much even if quenched (because martensite requires sufficient carbon). That level of detail might be beyond FE scope, but it's a reminder that material *composition* matters too in heat treatment outcomes (this is part of materials selection considerations).

Exam Handbook Search Cues (Not affiliated with or endorsed by NCEES): annealing; normalizing; quenching; tempering; martensite

Footnotes:

- *Martensite:* A **hard, brittle phase** that is formed when austenitized steel is quenched so rapidly that carbon atoms don't have time to diffuse into the equilibrium pearlite structure. Martensite has a distorted crystal lattice (tetragonal) and high internal strain. It's the reason quenched steel is so hard. However, because of its brittleness, martensite in practice is usually tempered to make tempered martensite (which contains fine carbide particles within a ferrite matrix, alleviating stress). Only ferrous alloys (steels and cast irons) form "martensite" on quenching; other metals can have analogous non-equilibrium structures, but the term martensite is chiefly used for steel.

- *Using the terms:* Sometimes "annealing" is used in a general sense to mean any treatment that softens a metal (even for non-ferrous metals, where phases like austenite/martensite aren't relevant). For example, copper wires are annealed (heated and slow cooled) to maximize ductility for drawing. The concept is always: anneal = soften by letting the microstructure relax and recrystallize; quench = harden (in steels, via martensite); temper = toughen after a quench; normalize = refine structure with air cooling. If you ground these definitions firmly, you can tackle any variation the exam throws at you.

Explanation & Analysis: Heat treatments are often tested in a qualitative way on the FE exam. The key is to associate each treatment with its **goals and effects**. Let's highlight each:

Annealing: Think of annealing as giving the metal a reset or a "stress-relief spa day." You heat it up, soak it at high temperature, and then cool it ever so slowly. The metal's internal structure realigns into a relaxed state. Dislocations from cold work are eliminated by recrystallization, grains grow larger, and any segregations can homogenize given enough time. After a full anneal, a metal (particularly steel) will be at its lowest hardness and strength but highest ductility. It's very easy to form or machine in this state. Exam-wise, if they say a metal is "heated and slow-cooled" or specifically "furnace cooled," immediately connect that to annealing and thus **soft, ductile outcome**. Also, if a question describes a part that's become too hard/brittle from service or working, the remedy might be "anneal it to restore ductility."

Normalizing: Normalizing is like annealing's brisker cousin. The metal is heated similarly, but allowed to cool in air, which is faster than furnace cooling. Why do this? Because that slightly faster cooling means the final grain size is smaller (the metal doesn't have as much time to grow huge grains during cooling). Smaller grains usually mean higher strength (per Hall-Petch relationship, though you won't need that formula on the FE exam). So normalized steel ends up a bit harder and stronger than annealed steel, yet still fairly ductile and stress-relieved. Normalizing is especially used for steel forgings or castings that have variable microstructures – a normalizing soak and air cool evens out the structure and refines it. On an exam question, if you see "air cooled steel" or the term "normalized," you should answer that the process **refines grain size and increases strength relative to annealing**. It's basically a treatment to ensure uniform fine structure.

Quenching: Quenching is all about locking in a high-hardness state. In plain terms, you take a hot metal and cool it so fast that the atoms don't have time to arrange into the soft phases. Using steel as the model: when red-hot austenite steel is dunked in water, it cools so quickly that instead of transforming to ferrite + cementite (which would be softer pearlite), it freezes into a strained phase (martensite). Martensite is *super hard*. So the point of quenching is to get maximum hardness and strength. But nature doesn't give that for free – the cost is brittleness. The sudden cooling can also cause distortion or cracking if the part is not designed for it (thick sections cool unevenly, causing stress). In exam terms, quenching a metal (usually steel) means **hardening**. If a question asks, "how do you harden steel significantly?" quenching is the answer (with the understanding that high carbon content is needed for a big effect). If they ask, "what's the structure of steel after quenching?" the answer is martensite (untempered). And if they mention a part breaking or being extremely brittle after heat treatment, suspect that it was quenched without tempering. Always tie quenching with hardness and brittleness.

Tempering: Tempering is nearly always discussed in tandem with quenching. After you quench steel and get that glass-like martensite, you usually **temper** it – meaning you reheat it to a moderate temperature (below the point where it would form austenite again, so it stays solid and mostly martensitic, but the martensite can decompose a bit). This moderate heat gives the metal a chance to *relax* a little: tiny iron carbide particles form and the matrix becomes tempered martensite, which is tougher. The result is a *trade-off*: tempered steel is not as insanely hard as as-quenched steel, but it's much more usable (tougher, less likely to crack). On the FE, a question might literally be: "Why is quenched steel tempered?" or "What effect does tempering have on a hardened steel's properties?" The answer: **to reduce brittleness and relieve internal stresses, increasing toughness.** If they ask about hardness, tempering *lowers hardness somewhat*, with the amount depending on tempering temperature/time. The higher you temper (approaching maybe 600 °C for steels), the more strength you lose but the more ductile/tough it becomes. Low-temperature tempers (like 200 °C) might only slightly reduce hardness but also only slightly improve toughness – sometimes done for tools that need to stay very hard. High temp tempers (like spring steel tempered to blue color ~300 °C or more) give up more hardness to gain significant toughness (so the material can flex without breaking). You probably won't need specific numbers, just know the trend.

In summary, heat treatments let us hit the "reset" (anneal), "tune up" (normalize), "turbo boost" (quench), or "balance out" (temper) buttons on a metal's properties after it's made or worked. The FE exam expects you to know which button does what. To avoid confusion, always link the key word to the outcome: **anneal → soft, normalize → refine (moderate harden), quench → harden (brittle), temper → toughen (reduce brittle)**. Keeping that straight will help eliminate wrong choices on exam questions.

As a closing thought, consider a real-world example to solidify these concepts: Suppose you have a steel chisel. You want it hard enough to cut into other metal or rock without the edge deforming, but you don't want it so brittle that it chips or shatters on impact. The manufacturing approach? Likely **forge** the chisel to shape (hot-work to give it a good fiberous grain flow), then **quench** the cutting end to get it very hard, and immediately **temper** it (perhaps you'll see the steel turn a faint straw or blue color at the edge, indicating tempering heat) to give it some toughness. The result: a hard cutting edge that won't dull immediately, yet one that won't crack like glass under hammer blows. This scenario ties together forming and heat treatment – exactly the kind of combined knowledge that makes you a better engineer and an informed FE exam taker.

Topic 07 - Phase Diagrams, Phase Transformations, and Heat Treating

Topic Intro – What & Why: This topic covers how alloy phases form and transform under different conditions, and how engineers use heat treatment to control material properties. You'll learn to read **binary phase diagrams** (for example, copper–nickel or iron–carbon systems) to determine what phases exist at a given composition and temperature, and how much of each phase forms (using the **lever rule**). You'll also understand special invariant transformations like **eutectic** (liquid → two solids) and **eutectoid** (one solid → two new solids) reactions – crucial in steels (the iron–carbon eutectoid produces pearlite at 0.76% C). We'll discuss how cooling rate affects microstructure: slow cooling gives pearlite, moderate cooling can give bainite, and rapid quenching produces martensite – these phases have very different hardness and mechanical properties. Finally, we examine **case hardening** processes (like carburizing and nitriding) which harden only a steel's surface by altering its composition or phase there. This knowledge matters because FE Mechanical Exam questions often ask about phase fractions (using diagrams), identifying microstructures from heat treatments, or selecting appropriate hardening processes. Typical question scenarios include: *"Given an alloy's phase diagram and composition, what phases and percentages are present at a certain temperature?"*, *"What microstructure results from quenching versus slow-cooling a steel?"*, or *"Which heat treatment process is best for hardening the surface of a gear?"*. Mastering this topic means you can confidently solve such problems by applying the phase diagram rules and understanding the principles of phase transformations and heat treatments.

K09.T07.S01 – Binary Phase Diagrams & Lever Rule

Principle Introduction: Binary phase diagrams map the stable phases of **two-component alloys** as a function of composition and temperature. Key features include **single-phase regions** (only liquid, only solid, etc.) and **two-phase regions** (where two phases coexist in equilibrium). To use a phase diagram, follow a horizontal tie line at the temperature of interest to see which phases are present and what their compositions are. If the point (overall composition and temperature) lies in a two-phase region, the alloy will split into two phases with compositions given by the tie-line endpoints. **The lever rule** is a simple linear interpolation method that lets you calculate the **fraction of each phase** in that two-phase mixture. It treats the overall composition point like a fulcrum on a lever (tie line): the phase fraction is proportional to the distance to the opposite side[^1]. Phase diagrams assume slow cooling (equilibrium) conditions, so phases have time to form per the diagram. Understanding binary diagrams is essential for predicting microstructures and is commonly tested on the FE exam, often with straightforward applications of the lever rule.

Equation Passport: Lever Rule – computes the weight fraction of each phase in a two-phase equilibrium mixture (binary alloy). It applies to any horizontal tie-line in a binary phase diagram, whether the two phases are both solids or a solid and a liquid.

Formula: For an alloy of overall composition x (in weight percent B) that lies in a two-phase region between phase α and phase β (or liquid L), the phase fractions are:

$$W_\alpha = \frac{x_\beta - x}{x_\beta - x_\alpha} \times 100\%, \qquad W_\beta = \frac{x - x_\alpha}{x_\beta - x_\alpha} \times 100\%,$$

where W_α and W_β are the weight percentages of phase α and β in the alloy. (If one phase is liquid, you can treat it as "β" in the formula.)

Variables and units:

- x – overall alloy composition (typically in weight% of the second component B[^1])
- x_α – composition of phase α at temperature T (wt% B in α)
- x_β – composition of phase β at temperature T (wt% B in β)
- W_α, W_β – resulting phase fractions (in % or as a decimal fraction if not multiplied by 100)

Assumptions & scope:

- The alloy is at equilibrium at the given T (cooled slowly enough for phases to form per the diagram).
- Only **two phases** are present. (If the point lies in a two-phase region, the lever rule applies. It does *not* apply in single-phase regions or if three phases co-exist at an invariant point.)
- Compositions are measured along a horizontal tie line at the specified temperature. Ensure you're using the correct phase boundary values x_α and x_β at that T.

Limit checks: If the overall composition x equals one of the phase's composition ($x = x_\alpha$ or $x = x_\beta$), then the alloy is entirely that phase (100% α or 100% β). If x is exactly midway between x_α and x_β, the formula gives $W_\alpha = W_\beta = 50\%$, which makes sense by symmetry. Always expect the majority phase to be the one whose composition is closest to the alloy's composition [^2].

Use vs. siblings: Use the **lever rule** whenever you need to find phase percentages from a binary phase diagram. It's essentially a **linear interpolation** between two phase boundary compositions. There's no simpler alternative for this; avoid guessing or assuming equal fractions without calculation, unless the composition is exactly centered. Do not confuse the lever rule with mixture property formulas (like rule of mixtures for properties) – lever rule is specifically about phase *amounts*.

Common exam traps:

- **Using the wrong values:** Make sure you plug in the phase boundary compositions *at the given temperature*, not the end compositions at 0% or 100% unless the tie line reaches those. Misreading the diagram can lead to swapping x_α and x_β or using the wrong numbers.
- **Fraction inversion:** Be careful which distance goes in the numerator. W_α uses the distance to the *other* phase's composition ($x_\beta - x$)[^2]. If you accidentally do $x - x_\alpha$ for W_α, you'll invert the result. A quick check is to see if your answer makes sense: if x is nearer to α's side, you should get more α than β.
- **Unit confusion:** Ensure the composition units are consistent. Most phase diagrams use weight percent (wt%), but some use atomic percent. The lever rule works

the same way, but you must use composition in the same unit system used by the diagram[^1].

Exam Handbook Search Cues (Not affiliated with or endorsed by NCEES): *binary phase diagram, lever rule, phase fraction, tie line* – These keywords will help you find phase diagram guidelines in the exam reference if needed.

Explanation & Analysis – How to use it: To apply the lever rule in a problem, follow these steps:

(1) **Identify the phases present** – Given the alloy's composition and temperature, locate that point on the phase diagram and note which two phases (α, β, or liquid) coexist around it.

(2) **Read the phase compositions** – Draw a horizontal line (tie line) at that temperature across the two-phase region. The intersections give you x_α and x_β, the compositions of the two phases in equilibrium.

(3) **Set up the lever rule** – Write the fraction of phase α as the distance from the overall composition to the β-phase composition, divided by the total distance between x_α and x_β. Likewise for phase β (distance to α's side over total).

(4) **Calculate and check** – Compute the numerical values. For example, if overall composition $x = 30\%$ B, $x_\alpha = 20\%$ B, and $x_\beta = 60\%$ B, then $W_\alpha = \frac{(60-30)}{(60-20)} = \frac{30}{40} = 0.75$ (75%) and $W_\beta = 25\%$. Check that they add to 100% and that the majority phase is the one closer to the alloy's composition (30 is closer to 20 than to 60, so α should indeed be more).

(5) **Interpret the result** – Conclude that, at the given conditions, the alloy is 75% α phase and 25% β phase by mass. In an exam context, you might then be asked about properties or microstructure based on those phase amounts. Remember that the lever rule is just a way to do a **mass balance** between phases: essentially, the overall alloy composition is the weighted average of phase compositions. If you ever forget the formula, you can derive it by equating alloy composition = $\alpha_{fraction} \cdot (x_\alpha) + \beta_{fraction} \cdot (x_\beta)$, with the fractions summing to 1. Solving those gives the lever rule formulas again. Practice is key: try a couple of diagram reading exercises so you're fluent in quickly extracting phase fractions with this method.

K09.T07.S02 – Eutectic & Eutectoid Transformations

Principle Introduction: Certain composition–temperature points in phase diagrams are special because a phase transformation occurs **isothermally** (at a fixed temperature) and **invariantly** (no degrees of freedom – it happens at a precise composition). Two fundamental types are **eutectic** and **eutectoid** transformations. In a **eutectic reaction**, one liquid phase solidifies into two different solid phases simultaneously when cooled through the eutectic temperature (the reverse happens on heating: two solids melt together into one liquid). In a eutectoid reaction, a single solid phase turns into two different solid phases at the same time as the material is cooled through the eutectoid temperature. These transformations typically produce **fine, lamellar microstructures** because the two product phases form together and are intimately mixed. They occur at specific alloy compositions that you can identify on a phase diagram by a point where three phases meet (e.g. liquid + α + β for eutectic, or α + β + γ for eutectoid). Understanding eutectic and eutectoid reactions matters because they often determine an alloy's structure and properties. For example, the **iron–carbon phase diagram** has a famous eutectoid at 0.76% C: austenite (γ) transforms into ferrite (α) + cementite (Fe_3C) at about 727 °C, forming pearlite. Questions on the FE exam might ask what pearlite is, what happens at the eutectoid composition, or simply to distinguish eutectic vs. eutectoid definitions. The key is to remember: *eutectic = liquid to two solids; eutectoid = one solid to two solids.*

Definition Passport: Eutectic vs. Eutectoid

- Eutectic Reaction (liquid → two solids): In plain language, a eutectic is a transformation where a **liquid** alloy of a particular composition solidifies into two different **solid phases** at the same time upon cooling. It's like the liquid "freezes" into an intermix of two solids. The classic example is a lead–tin solder alloy (~61.9% Sn) which solidifies at 183 °C into two solid phases (a Sn-rich solid and a Pb-rich solid) simultaneously. The word *eutectic* literally means "easily melted," because the eutectic composition has the lowest melting temperature in that alloy system. On a phase diagram, a eutectic point is where the liquid phase boundary (liquidus) meets the two solid phases' boundaries, typically forming a "V" or λ shape.

- Eutectoid Reaction (one solid → two solids): A eutectoid is similar in concept to a eutectic, but **starts with a solid** phase that transforms into two new solid phases upon cooling (no liquid involved). It happens at a specific composition and temperature as well. The most important example for mechanical engineers is the **iron–carbon eutectoid**: austenite (γ, a single solid phase of iron with dissolved carbon) at 0.76% carbon will, upon cooling past 727 °C, transform into **ferrite** (α, a low-carbon BCC iron solid) and **cementite** (Fe_{3C}, an iron carbide solid) simultaneously. The resulting microstructure is called **pearlite**, made up of alternating layers of **ferrite** and **cementite**. This eutectoid reaction can be written as:

γ (0.76% C) → α (0.022% C) + Fe_{3C} **(6.70% C) at 727 °C** *(eutectoid of iron–carbon).*
The term *eutectoid* means "like eutectic" – it behaves like a eutectic but in solid state. In the iron–carbon diagram, the eutectoid composition (about 0.76 wt% C) is where this special reaction occurs. Alloys with less carbon (hypoeutectoid steels) or more carbon (hypereutectoid steels) will not undergo the eutectoid in a single step; instead, they form some of one phase first (proeutectoid phase) before hitting the eutectoid temperature [^3].

Where it matters (exam impact): You'll encounter eutectic/eutectoid concepts in questions about steel microstructures or phase diagrams. For instance, *"What is pearlite?"* – answer: the lamellar α+Fe_3C microstructure from the eutectoid reaction in steel. Or *"At approximately what carbon content does steel have a eutectoid composition and what forms when it's cooled slowly?"* – answer: about 0.76% C, forming pearlite (α + Fe_3C). The exam may also present a small phase diagram snippet and ask which type of reaction is shown (eutectic vs eutectoid). Recognize that a eutectic involves a liquid phase, whereas a eutectoid is all-solid. This distinction can be a quick true/false or concept check.

Pitfalls or common confusion: It's easy to mix up the terminology since they sound similar. Remember: **"tic" → involves Liquid** (both words have a "t", maybe think *"meLT"* for eutectic), **"toid" → only s*O*lid** (both eutectoid and solid have an "o"). Another point of confusion: Students sometimes think steel's eutectoid (727 °C, 0.76% C) is a eutectic – it's not; steel does have a eutectic too, but that's at 4.3% C and about 1147 °C (liquid → austenite + Fe_3C, forming a microstructure called ledeburite). The eutectic (4.3% C) happens in cast iron, not in ordinary steel compositions, whereas the eutectoid (0.76% C) is central to steel heat treatment.

Micro-check: *True or False?* A **eutectoid** reaction involves a liquid phase. (**Answer:** False – a eutectoid is solid-state only. A eutectic is the one that involves a liquid.) This quick check confirms you know which term goes with which scenario.

Exam Handbook Search Cues (Not affiliated with or endorsed by NCEES): *eutectic, eutectoid, pearlite, iron–carbon diagram* – These terms can help locate reference figures (like the iron–iron carbide diagram) and definitions in the exam handbook. For example, searching "eutectoid" should bring up the iron–carbon eutectoid info.

Explanation & Analysis: In practical terms, these invariant reactions dictate microstructure. Let's delve a bit deeper using the iron–carbon system as the prime example (since it's likely to appear on the FE exam):

- **Eutectoid in Steel (0.76% C):** At high temperature (just above 727 °C), steel with ~0.76% carbon is a single-phase austenite (γ, FCC iron). Once the temperature drops to 727 °C, γ becomes unstable and **splits into two solids**: ferrite (α, BCC iron with very low carbon solubility) and cementite (Fe_{3C}, an iron carbide). These two phases form in an alternating layered structure known as **pearlite** (so named because it has a pearly sheen under a microscope). Pearlite is not a phase itself; it's a 2-phase microstructure (α + Fe_3C) resulting from the eutectoid reaction. If you have exactly 0.76% C and you cool very slowly, the entire sample will transform into 100% pearlite at 727 °C. If the carbon content is different, you won't get all pearlite: for example, a 0.4% C steel (hypoeutectoid) will start forming proeutectoid ferrite before 727 °C, and then the remaining austenite turns into pearlite at 727 °C [^3]. Similarly, a 1.0% C steel (hypereutectoid) forms proeutectoid cementite first, then pearlite. **Exam tip:** They love to ask "What is pearlite made of?" Answer: alternating layers of α and Fe_3C (ferrite and iron carbide). Also know that pearlite is relatively hard and strong due to the hard carbide layers, but not as hard as martensite (discussed later).

- **Eutectic in Cast Iron (4.3% C):** Although steels usually stay below 2% C, the iron–carbon diagram's eutectic point at 4.3% C, 1147 °C is worth a quick note. At this composition, liquid iron will solidify into austenite (γ) plus cementite (Fe_3C) simultaneously. The structure formed is called **ledeburite** (a mixture of austenite and cementite). In cast irons (which have >2% C), this eutectic plays a role in how the iron solidifies (often forming graphite instead of Fe_3C under certain conditions, but that's beyond our scope). For the FE exam, the main takeaway is recognizing a eutectic reaction graphically: one liquid splits into two solids at a fixed composition, often producing a characteristic lamellar structure if cooled quickly or a particular mixture if cooled slowly.

In summary, eutectic and eutectoid points are **hot spots on phase diagrams** where something dramatic happens: phases multiply! Make sure you can distinguish them: if you see liquid on one side of the reaction, it's a eutectic. If it's all solids, eutectoid. And remember the iron-carbon eutectoid specifically, since *pearlite in steels is practically guaranteed knowledge* for any mechanical engineer. It's the basis of why heat treating can make steel soft or hard depending on how we pass through that 727 °C transformation.

K09.T07.S03 – Cooling Rate & Microstructure (Pearlite vs. Bainite vs. Martensite)

Principle Introduction: The microstructure (and thus properties) of a steel (or other alloys) can vary wildly depending on **how fast or slow it's cooled** from the high-temperature phase. Equilibrium phase diagrams (like the iron–carbon diagram) assume slow cooling, where phases have time to form as predicted (e.g. ferrite + pearlite in a slowly cooled steel). However, if you cool faster, you can "outrun" some of these transformations. Steels are especially sensitive to cooling rate. Starting from austenite (γ) at high temperature, **slow cooling** (furnace cooling or air cooling) gives the equilibrium mixture (for medium-carbon steel, that's usually pearlite ± some proeutectoid phase). **Moderate cooling** (say, oil quenching or cooled in air for thinner pieces) might produce a different structure called **bainite**, which forms at lower temperatures over a longer time – it's a fine feathery mixture of ferrite and carbides, harder than pearlite but tougher than martensite. **Rapid quenching** (like plunging into water or brine) can suppress diffusion-driven transformations entirely, resulting in **martensite** – a hard, supersaturated phase that is not shown on the phase diagram (because it's a metastable, non-equilibrium phase). In effect, martensite is formed by a **diffusionless shear transformation**: the crystal structure changes nearly instantaneously (from FCC austenite to a distorted BCT structure) because carbon atoms don't have time to move. The trade-off is that martensite is extremely hard but also very brittle, so it's often tempered afterwards (reheated moderately) to improve toughness. Continuous Cooling Transformation (CCT) diagrams or Time-Temperature-Transformation (TTT) diagrams are tools that map this behavior – but even if you don't have the diagram, you should know the trends: *faster cooling = harder but more brittle microstructure*. This subtopic is crucial for understanding heat treatment outcomes. FE exam questions might ask something like: *"Which microstructure results from quenching a eutectoid steel?"* (Martensite) or *"How does cooling rate affect pearlite vs. bainite formation?"* or even give a TTT diagram and ask what happens at a certain cooling rate.

Key Microstructures from Cooling Austenite:

- **Pearlite (slow cool):** If a steel (especially near eutectoid composition) is cooled very slowly (like in a furnace), the austenite has plenty of time to undergo the equilibrium eutectoid reaction at ~727 °C. The result is pearlite – layers of ferrite and Fe_3C. Slower cooling tends to produce **coarser pearlite** (thicker layers) which is a bit softer because the phase separation had time to proceed and form more relaxed, thicker lamellae. Pearlite hardness is moderate: harder than pure ferrite, but much softer than martensite. It's strong and tough enough for many applications but not the hardest possible structure.

- **Bainite (moderate cool):** If cooling is faster such that you bypass forming pearlite at high temperatures but still allow some transformation at lower temperatures (say in the 250–550 °C range for steel), the austenite can transform into bainite. Bainite typically requires holding or slower cooling through that lower-temperature "bay" in the TTT diagram. It appears as a fine microstructure of ferrite plates or laths with tiny carbide particles (not the neat lamellae of pearlite). Bainite comes in two flavors: **upper bainite** (formed around 350–550 °C, feathery appearance) and **lower bainite** (around 250–350 °C, more acicular needles) – but such detail likely exceeds FE needs. The main point: bainite has higher hardness than pearlite (because of its fine structure) but retains

decent toughness (more than martensite). Many exam-prep discussions mention bainite as the intermediate case – you get it by cooling not super fast, but not super slow either, often using an interrupted quench or isothermal hold. If a question describes an "oil-quenched" medium-carbon steel that is somewhat hard but not glass-hard, bainite could be the answer.

- **Martensite (fast quench):** This is the hard one – literally. Quenching austenite rapidly (water quench, for instance) can produce martensite, a supersaturated solid solution of carbon in a distorted iron lattice (body-centered tetragonal, BCT). Martensite forms almost instantly as the austenite cools below a certain temperature (the martensite start temperature M_s), without diffusion. It's like the lattice gets "frozen" into a strained arrangement because carbon atoms didn't diffuse out in time. The result is extremely hard (martensite can be ~ 65 HRC or higher in a eutectoid steel) and brittle. In practice, martensite is usually tempered (reheated to e.g. 200 °C for an hour) to let some of the strain relax and precipitate tiny carbides, yielding **tempered martensite**, which is a bit softer (maybe 55 HRC) but much tougher. For the FE exam, remember: as-cast or normalized steel = ferrite + pearlite (moderate strength), quenched steel = martensite (very hard/brittle), quenched + tempered = tempered martensite (high strength, moderate toughness), and somewhere in between lies bainite (achieved by intermediate cooling).

- **Continuous Cooling vs. Isothermal:** A **TTT diagram** (isothermal transformation diagram) shows the time to start/finish transformations at constant temperature – often with a characteristic "C-curve" (nose) for pearlite/bainite formation. A **CCT diagram** (continuous cooling transformation) shifts those curves because continuous cooling requires reaching lower temperature to start transformations (so the curves move rightward/downward). The practical upshot: to get martensite, you must cool faster than the **critical cooling rate** that avoids the nose of the pearlite/bainite formation curves [^4]. If you miss the nose, austenite will partially transform to pearlite or bainite instead of martensite. The FE exam may not ask you to read a TTT/CCT graph in detail, but qualitatively: *quenching = martensite*, *slower = pearlite or bainite depending on rate*. Also, **alloying elements** in steel (like chromium, nickel, etc.) tend to slow down transformations (shifting the nose right) which makes it easier to form martensite even with slower cooling – that's why some alloy steels are "air-hardening." Basic plain carbon steel, however, usually needs water or oil quenching for full martensitic hardening.

Exam Handbook Search Cues (Not affiliated with or endorsed by NCEES): *quench, martensite, cooling rate, TTT diagram, bainite, pearlite* – The handbook might mention quenching and martensite (it does note that quenching can produce martensite instead of equilibrium phases). While it may not explain bainite explicitly, looking up "quench" or "martensite" will get you to the right section quickly if needed.

Explanation & Analysis: When tackling exam problems about microstructure vs. cooling rate, keep these points in mind:

16. **Identify the initial phase:** Typically, we're dealing with steel that has been fully austenitized (heated to form γ). This is the common starting point for heat treatment questions.
17. **Consider the cooling method described:** Are they water quenching (very rapid cool), oil quenching (moderate), air cool or furnace cool (slow)? If none is given explicitly, sometimes the carbon content and hardness clue you in (extremely hard implies quench).
18. **Match cooling to microstructure:**

    Water quench -> Martensite (very hard, brittle).

    Oil quench or moderate cooling -> possibly Bainite (if the steel can form it) or a mix of martensite and bainite for some alloy steels.

    Air cool (normalizing) -> Pearlite + some ferrite (for hypoeutectoid steels) or Pearlite + some cementite (for hypereutectoid). Basically near equilibrium, maybe slightly finer pearlite if air-cooled vs furnace-cooled.

    Furnace cool (very slow, annealing) -> Coarse Pearlite + proeutectoid phases.
19. **Relate to properties:** Pearlite/ferrite mixture gives a moderately soft steel (e.g., ~200 HB hardness in a eutectoid steel). Bainite would be harder (maybe ~300 HB, just guessing scale – not needed to memorize numbers, just relative ordering). Martensite is hardest (can be > 700 HV, rockwell ~65 C). If a question asks which treatment yields the highest hardness, answer is quenching to martensite. If it asks which yields the most ductility, answer is full anneal (coarse pearlite) or slow-cooled structure.
20. **Watch for tempered conditions:** The exam might mention *tempered martensite* as an ideal combination of strength and toughness – that's quench then reheat. Tempering isn't in the subtopic list explicitly, but in context, just know tempering reduces hardness a bit but improves toughness by relieving stresses and letting some micro-carbides form.

In essence, **cooling rate is a tool to control phase transformation**. Fast = non-equilibrium (martensite), intermediate = semi-equilibrium (bainite or fine pearlite), slow = equilibrium (coarse pearlite + proeutectoid phases). When you see a question on this, think of the *"race against the TTT curve"* [^4]: quenching is like outrunning the formation of pearlite (so you get martensite by not giving atoms time to form pearlite). A mid-speed cool lets you partially outrun pearlite at high temp but you might still get bainite lower down. And a leisurely cool just lets nature take its course (pearlite and whatever comes with it). Connect the dots from heat treatment to microstructure to properties, and you'll answer these questions with confidence.

K09.T07.S04 – Case Hardening Processes (Carburizing & Nitriding)

Principle Introduction: Not all applications call for making the entire metal part hard. Often, you want a **hard surface** for wear resistance but a **tough, ductile core** to absorb shocks. **Case hardening** refers to a group of processes that achieve exactly that: they harden only the outer "case" of a steel part, leaving the inside relatively softer. The two common case-hardening methods you should know are **carburizing** and **nitriding**. Both involve altering the surface chemistry of the steel so that the surface can turn into a hard phase. Carburizing **adds carbon** to the surface layer (usually in a low-carbon steel), then by quenching you get high-carbon martensite at the surface; extremely hard. Nitriding **adds nitrogen** to the surface, typically forming hard nitride compounds in alloy steel, which harden the surface without even requiring a quench [^5]. Case hardening is crucial for parts like gears, cams, shafts, etc., where the outside must resist wear and fatigue, while the core must withstand impact. The FE exam might pose a conceptual question such as, *"What is the purpose of carburizing a steel?"* or *"How can you harden the surface of a part without affecting its core?"* The key is recognizing carburizing and nitriding as surface treatments that create a hard case.

Definition Passport: Case Hardening – a heat treatment process that hardens only the **surface layer** of a steel component by changing its composition or microstructure, producing a **hard "shell"** and a **ductile interior**. Common methods:

- **Carburizing:** The steel part (usually low-carbon steel, e.g. 0.1% C) is heated to a high temperature (around 900 °C) in a carbon-rich environment (such as carbon-bearing gas, charcoal pack, or salt bath). At this temperature, carbon atoms diffuse into the surface of the steel, increasing the carbon content in a layer maybe 0.5–2 mm thick (depth depends on time and temperature). The part is then often **quenched** from the austenitizing temperature. The core, being low-carbon, transforms mostly to tough ferrite/pearlite, but the enriched carbon case transforms to high-carbon martensite (very hard). The result: a very hard outer layer (HRC 60+ possible) and a softer, tough core (maybe HRC 20–30). Carburizing essentially creates a gradient in carbon: high at surface, original low in core. This process is great for parts that need high wear resistance on the surface, like gear teeth or pins. The term *case carburizing* or *carbohardening* might be used. Often parts are also **tempered after carburizing** to relieve stresses (because quenching a high-carbon case can cause distortion/cracking if not tempered).

- **Nitriding:** This process infuses **nitrogen** into the surface. Typically done on special alloy steels that contain nitride-forming elements (like chromium, aluminum, molybdenum). The part is heated to a lower temperature (around 500–550 °C) in an ammonia gas atmosphere or plasma. At this temperature (which is below ferrite's critical temperature), nitrogen diffuses into the surface and forms very hard nitride compounds with the alloy elements (e.g. AlN, Fe_{4N}, CrN) within the surface layer. Nitriding doesn't require a quench – it's often done for many hours and then simply cooled down slowly. The surface "case" from nitriding can be extremely hard (comparable to a carburized case, sometimes harder) and very wear-resistant, while the core remains unaffected (since temperature was low, core stays ferrite/pearlite). An advantage of nitriding is **minimal distortion** (no quench) and the parts come out already hard. However, nitriding typically requires alloy steel and longer time. It's used for things like crankshafts, valve parts, gears in high-performance applications, where you want a hard, fatigue-resistant surface.

Where it matters (exam impact): If a question asks how to achieve a hard surface and a tough core, the answer is a case-hardening process. **Carburizing** is the go-to answer for through-hardening low-carbon steel surfaces. **Nitriding** is the answer if you specifically need a no-quench process or if the steel has those alloy elements. You might also see the term **carbonitriding**, which is a similar process adding both C and N at a somewhat lower temperature (it's like a thin-case carburizing, often used for small parts). The FE exam is unlikely to dive deep into differences between sub-methods; focus on the basic concept: adding carbon or nitrogen to the surface to harden it.

Common pitfalls: Don't confuse *case hardening* with just "quenching" or *through-hardening*. Quenching a high-carbon steel will harden the whole section (through-hardening), not selectively the surface. Case hardening is for when you start with a low-carbon (soft, tough) steel and only modify the surface. Another confusion might be between nitriding and nitrocarburizing or other similar terms – but generally, if you see "nitrogen" think nitriding. Also, note that case hardened parts typically should not be machined or ground deeply after hardening, or you'll remove the hard layer – sometimes exam questions hint at that (e.g., "why must grinding of a nitrided shaft be shallow?").

Micro-check: *Yes/No:* Does **carburizing** require a subsequent quench to achieve maximum hardness? (**Answer:** Yes. Carburizing adds carbon to surface; you then quench from austenite to get martensite. In contrast, nitriding does not require quenching – the hardness comes directly from nitride precipitates [^5].)

Exam Handbook Search Cues (Not affiliated with or endorsed by NCEES): *case hardening, carburizing, nitriding, surface hardness* – The handbook might not have extensive text on these, but searching "hardness" or "quench" may lead to clues. Ultimately, these are more conceptual processes, so you'll rely on understanding rather than handbook lookup.

Explanation & Analysis: Let's piece together how case hardening works and why it's used:

Imagine you have a **gear** made of low-carbon steel (0.2% C). Low-carbon steel is easily machinable and tough, but it can't be hardened much by direct quenching (it would just become slightly harder pearlite). If you **carburize** that gear, you essentially turn the outer 1 mm or so into high-carbon steel (~0.8% C or more). Now, when you quench the gear, that outer 1 mm transforms into high-carbon martensite (very hard, wear-resistant), while the inside remains low-carbon (which might only partly harden or just remain tougher ferrite/pearlite). The gear teeth now have a hard shell to resist wear and contact stress, supported by a ductile core that can absorb shock loads. This is ideal for durability. Carburizing is typically followed by tempering (to around 150–200 °C) to slightly soften the case and relieve stress, but the case will still be much harder than the core.

If instead you **nitrided** a finished steel part (say an alloy steel like 4140 or 4340 that's been heat-treated and tempered already), you would heat it at ~525 °C in ammonia. Over, say, 20–40 hours, nitrogen atoms seep in and form nitrides at the surface. You end up with an extremely hard, thin layer (maybe 0.3 mm thick) of nitrided steel. Because the temperature was relatively low, the part's core doesn't change (it remains tempered martensite, for example, if it was hardened before). When done, you just cool it slowly – no quench needed, so the part keeps its shape nicely (no quench distortion). The surface hardness from nitriding can exceed HRC 60 and has great wear and fatigue resistance (nitrided surfaces are also in compressive stress which helps fatigue life). Downside: nitriding takes a long time and only certain steels respond well.

Variations and related processes: Other case-hardening methods include **cyaniding** (using a cyanide salt bath to add C+N, faster but hazardous), **flame or induction hardening** (these don't change composition; instead they quickly heat the surface of a medium/high carbon steel with a flame or induction coil, then quench – effectively creating a martensitic case from the existing carbon. These require the steel to have enough carbon to harden; they're not diffusion processes). These variations might be beyond what FE expects, but it's good to recognize the terms. For FE exam purposes, carburizing and nitriding are the flagship methods. If a question simply says "surface hardening," carburizing is a safe bet if it involves adding carbon at high heat, and nitriding if it involves nitrogen at lower heat.

Typical values: A carburized case might have carbon content boosted from 0.2% to ~0.9% at the surface. Nitriding can achieve surface hardness around 1100 Vickers (very high). Case depths can range from 0.25 mm (shallow) to 2+ mm (for heavy sections) depending on process time and method. Such numbers likely won't be needed in the exam, but they give a sense that these processes alter only a small thickness compared to the whole part.

In summary, **case hardening** is a clever way to get the "best of both worlds" in steel: a hard exterior and a tough interior. The exam will expect you to know the basic mechanism (diffusing carbon or nitrogen) and the outcome (hard surface, soft core) of carburizing and nitriding. Remember that carburizing is usually followed by a quench (to form martensite in the case) [^5], while nitriding is a no-quench process that forms hard nitride precipitates. So if a question asks, "Which process can harden a steel without quenching?" you'd answer nitriding. If asked "How can you harden a low-carbon steel gear after machining?" you'd answer carburize and quench (to create a high-carbon martensitic case). With these concepts in your toolbox, you can confidently tackle case-hardening questions on the FE Mechanical Exam.

[^1]: Always confirm the units of composition. Phase diagrams often use weight percent (wt%), but some use atomic percent. The lever rule works with either, but you must use the correct values consistently. Don't mix wt% and at%. Also note that "wt% B" means weight percent of component B in the alloy (so 0% B = 100% A, and 100% B = 0% A on the diagram).

[^2]: Many students accidentally invert the lever rule fractions. A quick sanity check: if the overall composition x lies closer to x_α than to x_β, the alloy should contain more of phase α than phase β. If your calculation suggests otherwise, double-check which difference you used in the numerator!

[^3]: Steels with carbon content less than 0.76% (hypoeutectoid steels) start forming excess ferrite (α) before reaching the eutectoid temperature, resulting in a final structure of proeutectoid ferrite + pearlite. Steels with carbon above 0.76% (hypereutectoid) form excess cementite (Fe_{3C}) networks or particles before the rest transforms, leading to proeutectoid cementite + pearlite. These details explain microstructures in plain carbon steels, though the FE exam usually emphasizes recognizing pearlite vs. other structures rather than memorizing the term "hypoeutectoid."

[^4]: A TTT (Time-Temperature-Transformation) diagram for eutectoid steel has a characteristic "C-curve" (the **nose**) where pearlite or bainite begins to form if given enough time. Quenching quickly means you drop temperature fast enough that the alloy's path misses that nose – thus avoiding pearlite/bainite formation and landing into the martensite region. Continuous cooling (CCT) diagrams shift the nose to longer times compared to TTT, but the principle is the same: faster cooling is required to form martensite continuously. Alloy elements in steel (like Ni, Cr, Mo) tend to push the nose rightwards (slower transformations), which is why alloy steels can harden more deeply and in air in some cases.

[^5]: Nitriding typically does not require a quench. It is performed at ~500 °C so that hard nitrides form directly in the case. The part is often just cooled in air after nitriding, and the core retains whatever heat treatment it had. Carburizing, on the other hand, is done at high temperature (~900 °C) and is usually followed by quenching to trap carbon in a supersaturated martensitic structure in the case. Thus, carburized parts undergo a phase transformation on quenching, whereas nitrided parts get their hardness from compound formation without a phase change on cooling.

Topic 08 - Materials Selection

Topic Introduction: Selecting the right material is a core engineering decision – it's about picking the *best-suited* material for a design given multiple constraints. On the FE Mechanical Exam, you can expect conceptual questions asking which material is most appropriate for a given application or which property is critical in a scenario. **Why it matters:** Choosing poorly can lead to parts that are too heavy, too weak, or that fail prematurely (think of a plastic turbine blade – it would melt!). Typical questions might present a design requirement (e.g. *"lightweight but strong and corrosion-resistant"*) or a comparison of options (steel vs. aluminum, etc.) and ask you to identify the optimal material based on given criteria. In this chapter, we'll break down the key factors in material selection, how to use material property charts (like Ashby charts) to compare options, how specific environments dictate material choice, and common trade-offs between material classes. By the end, you'll know how to quickly weigh **mechanical strength**, **weight**, **corrosion resistance**, **cost**, and **manufacturability** – and confidently choose materials under exam conditions. *(Remember: exam questions often hinge on recognizing which property or criterion dominates in the scenario – practice spotting the keywords!)*

K09.T08.S01 – Criteria for Selecting Materials for Engineering Design

Principle Introduction – Material Selection Criteria: When selecting a material for an engineering design, you must balance several key criteria, each reflecting a different aspect of performance or practicality. The main criteria include:

- **Mechanical Strength:** A material's ability to withstand loads without failing, including yield strength (start of permanent deformation), ultimate tensile strength (maximum stress before fracture), hardness (resistance to indentation or wear), and related measures. Stronger materials can handle higher loads but might be heavier or more expensive.

  Unit tip: Strength is typically given in MPa or psi – be mindful of unit conversions on exam day.

- **Weight (Density):** The material's weight per unit volume, measured by density ρ (in $\mathrm{kg/m^3}$). Lower-density materials yield lighter designs – critical for anything that moves (vehicles, aircraft) or must be lifted. However, very light materials may be softer or weaker, so there's a trade-off. *(Don't confuse weight with mass: "lighter" usually implies lower density for a given volume.)*
- **Corrosion Resistance:** The ability to withstand degradation from the environment (rust, oxidation, chemical attack). For example, stainless steels form a protective oxide and resist rust, whereas plain carbon steel will corrode quickly in water or humid air. In chemical service, special alloys or polymers might be needed to resist aggressive acids or solvents. A material that corrodes can *lose* strength or contaminate the product, so this criterion is often a go/no-go filter for certain applications.
- **Cost:** Both the material cost per unit weight *and* the processing cost. Engineers must consider the project budget: exotic materials (titanium, composites) may outperform common steels or aluminum, but they can be prohibitively expensive. Cost also ties into availability – an affordable material that's hard to source or with long lead times can delay a project. *(Exam tip: If a question context mentions a tight budget or mass production, lean towards common, cost-effective materials.)*
- **Manufacturability:** How easily the material can be fabricated, machined, welded, cast, or formed into the desired shape. A material might have superb properties on paper but be difficult or costly to manufacture into the part you need. For instance, high-hardness alloys can be difficult to machine; ceramics are brittle to shape or drill; some materials require special welding procedures. Always consider if the chosen material is compatible with standard manufacturing processes (or if it needs exotic methods). Good manufacturability can reduce defects and cost.

Exam Handbook Search Cues (Not affiliated with or endorsed by NCEES): *yield strength*, *density*, *corrosion* (corrosion data for materials), *stainless* (for corrosion-resistant alloys), *manufacturability* (tolerances, fits) – These keywords will help locate relevant property definitions and tables in the exam reference. For example, searching "yield strength" brings up definitions of yield and tensile strength, and "density" can help find material density tables. The exam handbook won't explicitly tell you "use material X," but it provides material property data – knowing which property to look up is the key.

Footnotes & Pitfalls:

- *Units:* Remember that weight = mass × gravity; in material selection "lightweight" really implies low density (mass per volume). Don't mix up weight (N) and mass (kg) units. If given weight in lbf, convert to mass (divide by g_c) if needed.

- *Strength vs. Stiffness:* A high-strength material isn't always stiff (e.g. some titanium alloys are strong but lower in stiffness than steel). Decide if the design is strength-limited (yield or fracture) or stiffness-limited (deflection); the exam might imply this.

- *Balance multiple criteria:* There's rarely a one-size-fits-all. A material that scores high in one criterion (say, strongest) might score low in another (very heavy or costly). On the FE exam, identify the *dominant* requirement from the question stem. If a question emphasizes "lightweight," favor lower-density materials; if it says "in a corrosive environment," favor corrosion-resistant types even if others are stronger.

Where It's Used (Exam Impact): These criteria come into play in conceptual design questions. For instance, a problem may describe a component (like a bridge bolt, an airplane wing, or a chemical storage tank) and list constraints (load, weight limit, exposure to saltwater, etc.). You'll need to pick which material property is most critical and sometimes choose the material class that best fits. *Typical archetype:* "Which material is most suitable for [application] given [requirements]?" – the correct answer aligns with the key criterion (or the best compromise).

Micro-check: True or False – *The material with the highest tensile strength is always the best choice for an engineering part.* (Think

about weight, corrosion, and cost – the answer is **False**, as other factors can rule out the strongest material.)

K09.T08.S02 – Comparative Material Properties Charts & Performance Indices (Ashby Charts)

Principle Introduction – Using Material Property Charts: An **Ashby chart** (material selection chart) is a graphical tool that plots material properties against each other – for example, strength vs. density or stiffness vs. density – to allow visual comparison of materials. Each category of materials (metals, polymers, ceramics, composites, etc.) tends to occupy a distinct region on the chart. By overlaying design criteria on these charts, you can identify which materials maximize performance indices (ratios of properties) for your application. Key points:

- These charts often use logarithmic scales to accommodate the broad range of values. For instance, density might range from ultra-light foams at ~10^2 $\mathrm{kg/m^3}$ up to heavy metals at ~10^4 $\mathrm{kg/m^3}$, while Young's modulus might span from rubber's ~10^{-1} GPa to ceramics' hundreds of GPa.
- **Performance Index:** This is a combined property measure used to rank materials for a specific design goal. For example, if you want maximum stiffness for minimum weight (like in an aircraft wing or a bike frame), a useful index is $M = \frac{E}{\rho}$, the ratio of Young's modulus E to density ρ. Materials with higher E/ρ (stiffness per unit weight) are preferred for lightweight stiffness-critical designs. Similarly, for strength-limited lightweight design, one might use σ_y/ρ (yield strength per density) as the index. Ashby charts help visualize these ratios as diagonal "selection lines" – materials above a certain line have higher performance indices.
- By plotting materials on a chart, you can quickly eliminate categories that can't meet your requirements. **Example:** If a question asks for a material for a stiff, lightweight beam, you'd mentally or graphically consider a stiffness–density chart. Materials like composites or aluminum (lighter, decent stiffness) would stand out over something like lead (high density) or rubber (low stiffness).
- Ashby charts emphasize trade-offs: no material is best in *all* properties. They teach us which materials are *efficient* for a given combination. Metals are strong and stiff but heavy; polymers are light but low stiffness; composites can achieve high specific strength/stiffness but may be costly and directional. On the exam, you might get a qualitative question like "Which material class offers a high strength-to-weight ratio?" – with answer: *composites or aluminum alloys*, based on recognizing those performance indices.
- **How to use on exam:** While you won't be plotting graphs in the exam, you should understand the *trend*. If given data or a figure, identify the axes and see which material lies in the desirable corner (e.g. low density, high strength). If no figure, use your knowledge: e.g., "for high strength at low weight, fiber-reinforced composites and certain Al/Ti alloys excel; for stiffness, look at ceramics or composites, etc." Practice interpreting any provided chart: they often have log scales – be careful reading those (each tick might be a power of ten).

Example Material Properties Chart (Ashby-style): The figure above plots **Young's Modulus (stiffness)** vs. **Density** on logarithmic scales for various material classes. Each point represents a typical range for a material family (not individual alloys): **Metals** (orange) cluster at high density (7,000–8,000+ kg/m³) and high stiffness (~50–200 GPa). **Polymers** (blue) sit at low stiffness (around 1–5 GPa) and low density (~1,000 kg/m³). **Ceramics** (green) are very stiff (up to 400 GPa) but moderately dense (2,000–4,000 kg/m³). **Composites** (red) achieve high stiffness at low densities (e.g., carbon fiber composites ~100–150 GPa at ~1,600 kg/m³), outpacing most metals in specific stiffness. **Natural materials like Wood** (purple) and **Foams** (yellow) occupy the low end of both axes. *How to read it:* a material towards the upper-left of this chart (high E, low ρ) is ideal for lightweight stiffness. A diagonal line sloping downwards would indicate a constant E/ρ ratio – materials above that line have a higher stiffness-to-weight performance. For instance, moving horizontally right increases weight; moving vertically up increases stiffness – the goal is to maximize vertical position for a given horizontal position.

Axes & Quantities: In such charts, **x-axis** might be Density ρ (kg/m³) and **y-axis** could be Young's Modulus E (GPa) or Strength (MPa), often both on log scales to spread out the data. Each axis spans orders of magnitude (note the powers of 10 on the grid). **Key regions:** Broad material categories form clusters: Metals in a high-ρ, high-E region; Polymers in low-ρ, low-E; Ceramics high-E but mid-ρ; Composites bridging high E at relatively low ρ. These clusters reflect inherent material differences (e.g. metals have dense atomic packing, hence heavy but stiff; polymers have flexible molecular chains, hence low stiffness and density).

How to read it (Exam-style move): Start with your design goal – say you need **maximize** a ratio like E/ρ. On the chart, that corresponds to finding materials as **far up and left** as possible (draw a line of slope 1 in log-log space representing constant E/ρ, then move it up until it just touches the material region – materials above that line are better than the threshold). Conversely, if you need low density but don't care about stiffness, you look simply to the left side. If both high strength and toughness are needed, you'd consult a strength-toughness chart to find materials that lie in the high-high quadrant of those axes. The exam may simplistically describe this without an actual graph: you should know, for example, that **fiber composites and aluminum/titanium alloys** have high strength-to-weight, or that **ceramics** have high stiffness but can be brittle (low toughness, which would show up on a chart plotting toughness).

Common Misreads & Pitfalls:

- *Log scale confusion:* Many forget that equal spacing on a log axis means a tenfold change. For example, a modest gap on the x-axis from 10^3 to 10^4 is actually a 10× density increase! Be careful reading values; if an Ashby-type diagram is provided, double-check if axes are log.

- *Ignoring units:* Ensure you compare materials in consistent units. If one source gives density in $\mathrm{lb/ft^3}$ and another in $\mathrm{kg/m^3}$, convert one to the other before judging. The exam handbook density table lists ρ in SI units (kg/m³); remember water is 1000 kg/m³ as a baseline.

- *Chasing one property only:* The chart highlights one property vs another. A trap is to pick a material that is extreme in one property but forget the un-plotted ones. For instance, a material could have great E/ρ but awful fracture toughness (ceramics are a classic case: excellent stiffness/weight, but prone to brittle fracture). Always consider if there's another limiting factor mentioned in the problem (e.g., "needs to withstand impact" would rule out a ceramic despite its stiffness).

Exam Handbook Search Cues (Not affiliated with or endorsed by NCEES): While the exam reference may not show an "Ashby chart" explicitly, it contains **tables of material properties** and **typical values**. Useful keywords include *"Density ρ"*, *"Young's Modulus E"*, *"Typical material properties"*, or specific materials like *"Aluminum"*, *"Titanium"* to find their properties. For instance, the handbook table lists density and melting points for elements – knowing aluminum is ~2700 kg/m³ vs steel ~7850 kg/m³ helps evaluate weight differences quickly. If a question hints at "specific strength," you might search the handbook for the strength of a given alloy and compare to density manually (the term *specific strength* may not appear, but you can compute it). Also, recognize **creep** and **fatigue** considerations: the handbook defines creep (time-dependent deformation at stress and temperature) – a clue that if high-temperature long-term use is in play, material selection should consider creep-resistant materials (often found via key terms like *"creep"* or *"melting point"* in tables).

Footnotes:

- The performance index formula $M = E/\rho$ we showed assumes bending stiffness is key and cross-sections can be adjusted freely. Different scenarios use different indices (e.g. for a tie rod under tension, $M = \sigma_y/\rho$ might be more appropriate). The exam won't have you derive these, but understanding them guides intuitive choices.

- Some materials cheat charts by combining properties: e.g. **alloys** or **heat-treatments** can improve strength without big weight change, shifting a material's position in a chart. Tool steels, for example, have higher strength (moving up) but same density as plain steel. In an exam context, just remember broad classes rather than specifics: e.g. "magnesium alloys are even lighter than aluminum but generally weaker and less used due to flammability/cost," etc.

Micro-check: If a material has a **density** half that of another, but the same **Young's modulus**, how does its E/ρ compare? (*Answer:* Twice as high – it's better for stiffness-critical lightweight design. Now, if the question instead needed *strength* per weight, you'd compare σ/ρ similarly. Always pick the material with the higher relevant index for the goal.)

K09.T08.S03 – Material Selection for Specific Environments

Principle Introduction – Environment-Specific Materials: The operating environment can dictate material choice as much as mechanical loads do. Some materials thrive in hot, corrosive, or cryogenic environments while others fail dramatically outside benign conditions. When selecting for a **specific environment**, consider factors like temperature limits, chemical compatibility, humidity, UV exposure, and more. Key scenarios:

High-Temperature Applications: At elevated temperatures (hundreds of °C), many materials lose strength, creep (deform slowly under load) becomes significant, and oxidation accelerates. Materials for high-heat service (e.g. turbine blades, engine exhaust components, furnace parts) must retain mechanical strength and not melt or excessively deform. **Common choices:** Nickel-based superalloys (e.g. Inconel) are formulated to withstand high stresses at ~700–1000 °C (with excellent creep resistance). Refractory metals like **tungsten** (melting point $\sim 3420°C$) or **molybdenum** ($2610°C$) have extremely high melting points – they resist deformation at red-hot temperatures (used in furnace elements, rocket nozzles). Ceramics (oxides, carbides) can handle even higher temperatures without melting and don't creep like metals, but they are brittle – often used with compressive loads or as coatings. Stainless steels can be used up to ~600°C depending on grade before they lose significant strength. *Important:* Thermal expansion and thermal shock resistance also matter – for example, ceramics have low thermal expansion (good dimensional stability when hot) but can crack under rapid temperature change. On the exam, if asked what material suits a high-temp use, look for keywords like *"heat-resistant alloy"*, *"refractory"*, or *"ceramic"*. Avoid low-melting metals (like aluminum which melts at ~660°C) or polymers (which degrade at a few hundred °C at best) for such applications.

Corrosive or Chemical Environments: When a material will be exposed to chemicals, moisture, or harsh atmospheres, **corrosion resistance** is paramount. For general wet or humid environments (and food/medical contexts), **stainless steels** (especially 304, 316 types) are go-to because they form a passive chromium-oxide layer that stops rust. In marine environments (saltwater), stainless, bronzes, or special aluminum alloys (with coatings) are used to resist salt corrosion. For strong **acids or chlorine** environments, even stainless might corrode – nickel alloys (Hastelloy, Monel), titanium, or specialty plastics (Teflon/PTFE, which is almost universally chemical inert) are selected. For example, a chemical storage tank for concentrated sulfuric acid might use a specific corrosion-resistant alloy or a polymer liner, since common steel would be eaten away rapidly. The FE exam might frame this as: "What material would you select for piping carrying concentrated nitric acid?" with an answer like "Use Teflon or a high-alloy stainless (or glass) due to corrosion." Similarly, **corrosion-resistant alloys** are needed for high-temperature corrosion (oxidation) resistance – e.g. adding chromium/aluminum in alloys forms stable oxides.

Specific Example – Material Compatibility Chart: The exam reference includes tables of corrosion data for materials (e.g. how Neoprene, Stainless 316, etc., perform in various chemicals). You won't memorize these, but know the trend: some rubbers (neoprene, viton) are "satisfactory" with certain chemicals, some metals corrode quickly in others. If an exam question gives you a snippet of such a chart, you'll use it to pick the material labeled "satisfactory" for that chemical.

Low-Temperature (Cryogenic) Environments: Though not explicitly in the outline, it's worth noting: at very low temperatures, some metals (especially plain carbon steels) become brittle (ductile-to-brittle transition). Austenitic stainless steels or aluminum alloys do *not* show this embrittlement and are good for cryogenic use. So if the scenario hints at very cold conditions (like a liquid nitrogen container), steer toward materials known to remain tough when cold (stainless, aluminum, certain plastics) and avoid ones that could crack (like normal steel or cast iron, unless specially treated).

Other environmental factors: Wear/Abrasion: If the environment involves abrasive wear (sand, slurry), you may need surface-hardened steels or ceramics (for their hardness). **Radiation:** nuclear environments use materials that resist radiation damage (graphite, certain stainless steels). **UV exposure:** outdoors plastics need UV stabilizers or they degrade (so maybe metals or UV-resistant polymers). The key is to match the material's inherent resistance to the dominant environmental hazard.

Exam Handbook Search Cues (Not affiliated with or endorsed by NCEES): *"Creep"*, *"oxidation"*, *"corrosion"*, *"melting point"*, *"stainless 316"*, *"chemical compatibility"*. These terms help locate information like melting points of metals or tables of corrosion rates in the handbook. For example, searching "STAINLESS 316" in the reference might show a corrosion rate entry hinting at its

performance. Also, *"Hazardous materials"* or *"corrosion allowance"* might appear in civil/environmental sections, but in mechanical context, focus on material science portions that list properties like we did. If a question mentions high temperature, looking up *"creep"* reinforces that you need a creep-resistant material. If it mentions a chemical by name, the handbook's **Chemical Engineering** section might list compatibility (though not guaranteed); often, the exam question itself will state if a material is acceptable or not.

Pitfalls & Footnotes:

- *Mixing up strength and corrosion:* A classic mistake is picking the strongest alloy for a chemical environment without realizing it *corrodes*. A moderately strong but corrosion-proof material (e.g. a polymer liner) could be far superior in practice. Always address environmental compatibility first – a corroding material loses strength rapidly.

- *High-temp metal vs. ceramic:* Metals will soften at high temp and can creep; ceramics handle heat but break if tensile stress or thermal shock. On a question, if something like "constant high-pressure steam at 550°C" is mentioned, a stainless steel might be at its limit; a chrome-moly alloy (like P91 steel) or a Ni-based alloy is intended. If "very high temperature, no mechanical shock," a ceramic could work (like furnace insulation bricks). Pay attention to whether toughness or shock is needed – if yes, lean toward tough alloys; if not, ceramics might be okay.

- *Coatings and treatments:* Sometimes the solution is not changing the bulk material but adding a protective coating (like painting steel for corrosion, or surface-treating for wear). The FE might not dive deep here, but be aware: an inexpensive base material with a coating can meet environment needs (e.g. steel with ceramic thermal barrier in turbines). If the answer choices include a coated material, consider it as a viable compromise.

Where It's Used (Exam Impact): Questions involving environment often read like "What material would you use for X environment or Y chemical?" They are testing if you know the material that won't fail in those conditions. They may also combine environment with mechanical needs (e.g., "a high-strength material for outdoor use in a marine climate" – best answer might be a particular stainless steel or aluminum alloy, combining strength + corrosion resistance). So, expect to apply *process of elimination*: rule out materials that can't handle the stated environment. The exam reference can provide hints (melting points, notes on corrosion resistance), but much is logic and memory of general material behavior.

Micro-check: *Pop quiz:* Your design is for a **chemical reactor vessel** that will handle hot concentrated acid. You have options of (A) Carbon steel (cheap, strong), (B) 7075 Aluminum alloy (strong, light), (C) 316 Stainless Steel (corrosion-resistant), (D) Nylon (chemical-resistant plastic). Which do you pick? **Answer:** (C) 316 Stainless – it's specifically developed for corrosion resistance in aggressive environments and can handle heat. (Carbon steel would corrode, aluminum would be eaten by acid and can't take the acid's reactivity, nylon might not handle the heat and could absorb chemicals/swells). This is how you should think through environment questions: eliminate the incompatible ones, and choose the material that survives the environment even if it's not the absolute strongest.

K09.T08.S04 – Examples of Material Trade-offs (Aluminum vs. Steel, Composites vs. Metals)

Principle Introduction – Material Trade-offs: In engineering, selecting materials often means making *trade-offs*. No single material is perfect in all aspects, so you choose based on what matters most for the design. Two classic comparisons illustrate this well: **aluminum vs. steel** and **composites vs. metals**. Understanding these examples will prepare you for exam questions where you must justify a material choice or anticipate the downsides of an alternative.

Example 1: Aluminum vs. Steel – This is a common decision in structures and machines:

- **Weight:** Aluminum is about one-third the density of steel (≈ 2700 kg/m³ vs. 7850 kg/m³). This means for the same volume, an aluminum part weighs ~1/3 as much as a steel part. For weight-critical applications (vehicles, aerospace), this is a huge advantage – switching from steel to aluminum can drastically reduce mass.
- **Strength:** Steel (especially high-grade alloy steel) generally has a higher yield strength and ultimate strength than common aluminum alloys. Mild steel yields around 250 MPa, and high-strength steels can go above 600 MPa. Aluminum alloys (e.g. 6061-T6) yield around 250 MPa, some specialized ones (7075-T6) reach ~500 MPa, but in absolute terms the strongest steels still outmatch the strongest aluminums. However, when considering *strength-to-weight ratio* (MPa per density), high-grade aluminum can rival steel. The FE exam might present a scenario asking which material to use for a light yet strong component – the answer could hinge on realizing aluminum can provide the needed strength at much lower weight, *if* absolute strength requirements aren't beyond aluminum's capabilities.
- **Stiffness:** Here steel has a clear advantage. Steel's Young's Modulus $E \approx 200$ GPa, while aluminum's $E \approx 70$ GPa (about one-third). This means for the same shape and load, an aluminum part will deflect ~3× more than a steel part. In stiffness-limited designs (minimal deflection allowed, like machine frames or precision equipment), steel often wins because aluminum would require a much bulkier cross-section to achieve the same rigidity. This is a key trade-off: if you swap steel for aluminum to save weight, you might have to make the aluminum part thicker or use deeper sections to meet stiffness, which can eat into the weight savings.
- **Corrosion:** Bare steel rusts in air/water, while aluminum naturally forms an oxide layer that *protects* it from further corrosion (so it won't "rust through"). In a normal atmosphere, aluminum is essentially corrosion-proof; steel needs paint, coating, or alloying (stainless) to resist rust. In salty or harsh environments, aluminum can corrode (pitting) but still generally better than unprotected steel. So for outdoor use without protective coating, aluminum has the edge. *(However, note:* certain aluminum alloys can suffer stress-corrosion cracking; and in extremely high-pH or mercury exposures, aluminum has issues – but those are niche cases).
- **Cost & Manufacturability:** Steel is cheap and ubiquitous; aluminum is more expensive per kg. Steel is also easier to weld (aluminum's high thermal conductivity and oxide layer make welding trickier) and can be readily machined, forged, or cast with established methods. Aluminum machines nicely too (it's softer), and

can be extruded into complex shapes that steel might require welding to achieve. The cost trade-off: if weight isn't important, steel often wins on cost. If weight savings lead to operational cost savings (like fuel efficiency in transport), then spending more on aluminum is justified.

- **Bottom line:** Use **aluminum** when weight reduction is critical and the operating loads can be handled with slightly lower absolute strength or with a bit more material, and corrosion resistance with minimal maintenance is desired. Use **steel** when you need maximum strength or stiffness in a given volume, cost must be low, or when high temperatures are involved (steel can handle higher service temps than aluminum, which loses strength above ~150°C).

Example 2: Composites vs. Metals (for weight-critical designs) – Composite materials (like carbon fiber reinforced polymers, CFRP) versus traditional metals:

- **Specific Strength & Stiffness:** Advanced composites are superstar materials for specific properties. A carbon-fiber composite can have a tensile strength well over 1000 MPa (comparable to the strongest steels) while its density is low (~1600 kg/m³). The specific strength (strength/ρ) and specific stiffness (E/ρ) of carbon composites are among the highest of any material – that's why they're used in aircraft, spacecraft, and race cars. For instance, CFRP bicycle frames and airplane wings achieve strength and stiffness at a fraction of the weight of an aluminum or steel counterpart. So if an exam question asks, "What material type yields the highest strength-to-weight for a beam or panel?", a correct answer would be **fiber-reinforced composites**.
- **Directional Properties (Anisotropy):** Unlike metals, which are isotropic (same properties in all directions), composites are usually layered and fiber-oriented, meaning they are very strong/stiff *along the fiber direction* but much weaker across it. In practice, engineers design the layup such that fibers align with principal stress directions. On the exam, this could be a conceptual point: e.g., "Why might a carbon fiber part fail if loaded in an off-axis direction?" – because its strength perpendicular to fibers is low (governed by the weaker matrix resin). Metals don't have this issue – they yield more uniformly.
- **Brittleness vs. Ductility:** Most composites (with stiff fibers like carbon or glass) are relatively brittle – they don't yield significantly; they shatter or delaminate when overloaded. Metals (like aluminum, steel) often have ductile behavior – they yield and give warning before breaking. In design, this means composites have less margin for overload and require safety factors to avoid any sudden fracture. The FE exam might not go deep here, but qualitatively: if a question asks about material for an application needing **energy absorption or toughness**, metal might be preferred over a composite.
- **Manufacturing & Cost:** Composites are expensive and labor-intensive to produce (laying fiber cloth, resin curing, etc.), whereas metals can be stamped, welded, and mass-produced relatively cheaply. Composites also often require special quality control (voids in layup, bonding issues). For one-off high-performance parts, composites are king; for millions of inexpensive parts (like bolts or car chassis), metals reign due to cost. On the exam, consider this: if the scenario is aerospace or high-performance sporting goods, composites make sense; if it's a common consumer product or heavy machinery, composites might be overkill or too costly.
- **Thermal and Environmental Behavior:** Composites can have poor performance in high temperatures (the polymer matrix can soften or burn above ~200°C unless special resins are used) – so metals or ceramic matrix composites would be needed for heat. Also, some composites can absorb moisture or UV and degrade over time, whereas metals might just corrode (which can be mitigated). If an exam question implies operation at high heat or very long-term durability, think about whether a composite's matrix will hold up – if not, a metal or ceramic might be better.
- **Trade-off summary:** Use **composites** when weight must be minimized and budget allows – especially if loads are well-understood and can be aligned with fiber directions (like aircraft wings, where fibers run along the span). Use **metals** when cost, isotropy, or toughness are more important – or if the environment is too harsh for polymers (e.g., high temperature where an aluminum or titanium alloy would survive but a polymer composite would not).

Exam Handbook Search Cues (Not affiliated with or endorsed by NCEES): To compare materials, you might search specific materials in the handbook data. For instance, *"Aluminum 6061-T6"*, *"A36 steel"*, *"Composite (if any data)"*. The handbook does list some **representative material properties** (like the fracture toughness table listing values for 2024 aluminum vs. 4340 steel vs. ceramics – which already tells you aluminum and steel have much higher toughness than ceramics). It may not explicitly list composite properties, but if given in a problem, they'll provide necessary info. Also search *"modulus"* or *"density"* as mentioned to get numeric comparisons. Recognize typical densities: steel ~ 7.8 g/cc, aluminum ~ 2.7 g/cc, fiberglass ~ 1.9 g/cc, carbon fiber composite ~ 1.6 g/cc. If a question provides a table of properties, use it to compute an index (like strength/weight) for each option to objectively choose – often the exam's provided data is enough to make the right choice clear.

Pitfalls & Things to Remember:

- *Assuming lighter is always better:* On the exam, "lightweight" is good only if strength or stiffness are sufficient. A very light material that can't handle the load is not a solution. For example, magnesium alloys are even lighter than aluminum, but they have other drawbacks (flammability, lower ductility). So don't pick a material just because it's light – ensure it meets other requirements given.

- *Ignoring geometry:* Material selection and design geometry go hand-in-hand. If a question states a part's dimensions are fixed, then you truly compare material capabilities one-to-one. If shape can change, a weaker material can sometimes be used by making the part thicker. But often exam questions keep it simple: assume similar shape or that the material change doesn't allow drastic redesign. If a question implicitly expects you to keep geometry same, then a lower modulus material will cause more deflection – that could be a deal-breaker even if strength was okay. Keep an eye out for clues like "same dimensions" or "retrofit this material in place of that one" – implying geometry is fixed.

- *Cost-blind decisions:* In trade-off questions, if two materials meet technical requirements, cost or ease of use becomes tie-breaker. The exam might not give you dollar values, but qualitatively you

should know steel < aluminum < titanium < exotics in cost order (from cheapest to priciest, generally). Composites usually high cost. If they mention "for mass production of a consumer product," lean toward cheaper materials (steel or aluminum) over anything exotic.

- *Safety factors:* If using a material with more variability (like composites can vary by layup quality), designs often use higher safety factors. The FE might not directly ask that, but it's a consideration if comparing, say, a well-characterized metal vs a new composite.

Where It's Used (Exam Impact): These trade-off considerations appear in questions like "Why choose material X over Y for a design?" or "What is a drawback of using [material] instead of [another] in this application?" For instance, *"An engineer is considering replacing a steel automobile component with an aluminum alloy component of identical dimensions. What effects will this have?"* A correct analysis: weight drops (~1/3), but stiffness drops to ~1/3, meaning more deflection; also corrosion improves (no rust) but material cost rises. The exam answer might be phrased in terms of those outcomes. So, be prepared to identify both pros **and** cons when swapping materials. If the question focuses on one aspect (like weight saving), answer with that focus (aluminum reduces weight); if it asks for a consequence, mention the trade-off (increased deflection, etc.).

Micro-check: You need to choose a material for a **drone frame** where minimizing weight is crucial, but it must also survive minor crashes (absorbing impact). Would you pick a carbon-fiber composite or aluminum? **Thought process:** Carbon fiber is lighter and very stiff, great for flying efficiency – but it's brittle in a crash. Aluminum is a bit heavier, more yielding, and can dent rather than shatter. **Answer:** Likely **aluminum** for a hobbyist drone frame (unless it's a high-end racing drone) because it can deform and be bent back, whereas carbon fiber might crack on impact. This exemplifies how trade-offs work: the "best" material depends on which performance aspect you prioritize and the use-case realities. Always consider the context given in the exam question – it will signal what trade-off to make.

Topic 09 - Corrosion Mechanisms and Control

Topic Intro: Corrosion is the slow deterioration of a material (typically a metal) due to chemical or electrochemical reactions with its surrounding environment. In practical terms, it's why iron rusts, why boats need sacrificial zinc plates, and why material selection is critical for pipelines and chemical plants. On the **FE Mechanical Exam**, corrosion questions typically focus on identifying corrosion **types** in a scenario, understanding the basic **electrochemical cell** driving corrosion, or choosing an appropriate **prevention method**. These questions are usually conceptual; e.g. asking which metal will corrode in a two-metal pair, or which corrosion-control technique is best for a given situation—rather than heavy calculations. Still, a fundamental grasp of corrosion principles will let you quickly eliminate wrong answers and pick the safest material or method on exam day.

K09.T09.S01 – Common Corrosion Mechanisms

Principle Introduction: Corrosion comes in several flavors, each with distinct patterns and causes. You should be able to recognize the **common corrosion mechanisms** and their telltale signs:

- **Uniform Corrosion:** A **general attack** that eats away the entire surface more or less evenly. *Example:* plain carbon steel rusting uniformly in the atmosphere. This form is **predictable** and often accounted for by adding corrosion allowance (extra thickness) since the material thins at a steady, slow rate.
- **Galvanic Corrosion:** An accelerated attack that occurs when **two dissimilar metals** are electrically connected in a corrosive electrolyte. One metal becomes the **anode** (and corrodes) while the other becomes the **cathode** (and is protected). *Think:* a **bimetallic couple** like steel bolts on a copper plate in seawater – the steel (more active metal) will corrode much faster than it would alone.
- **Pitting Corrosion:** A highly **localized** attack that produces tiny holes or "pits" in the metal. It often affects metals that normally form protective films (like stainless steel or aluminum) in the presence of specific aggressive ions (e.g. chloride in saltwater) that break down the film. Pitting is dangerous because it's **hard to detect** (small deep pits) and can lead to sudden failure with minimal overall material loss.
- **Crevice Corrosion:** A localized attack similar to pitting, but specifically occurring in **stagnant micro-environments** like under gaskets, lap joints, or deposits. A **crevice** or tight space allows the chemistry inside it to differ from the outside (often oxygen-depleted, acidic), setting up a corrosion cell. Even a metal that resists uniform corrosion can corrode inside a crevice. *Design note:* avoid **dead pockets** where water can stagnate.
- **Stress-Corrosion Cracking (SCC):** A nasty failure mode where **tensile stress** (either applied or residual) and a **corrosive environment** work together to cause **brittle cracks** in a normally ductile metal. The metal might barely corrode overall, but it **snaps** due to crack growth. *Classic example:* chloride SCC in stainless steel under stress (hairline cracks form and grow, leading to sudden fracture). SCC is often specific – only certain metal/environment combinations crack this way (e.g. brass in ammonia, high-strength steels in seawater).

Exam Handbook Search Cues (Not affiliated with or endorsed by NCEES): corrosion; uniform attack; galvanic; pitting; crevice; stress corrosion cracking; SCC; brittle cracks

Footnotes:

- *Predictability:* Uniform corrosion, though damaging over time, is at least predictable and often allowable in design (with corrosion allowance). The **localized forms (pitting, crevice, SCC)** are more dangerous for exam purposes – they can cause unexpected failures, so watch for clues in questions that hint at "sudden leak in an otherwise thick pipe" (pitting) or "crack found in a stressed component after exposure to chemicals" (SCC).

- *Galvanic Pair Basics:* In galvanic corrosion, the **more active metal** (lower on the galvanic series, more prone to oxidize) is the one that corrodes. A common **trap** is thinking the larger piece will corrode – actually, it's about electrochemical activity, not size (though **area matters**: a small anode coupled to a large cathode will corrode extremely fast!). Always identify which metal is anodic: e.g. **magnesium > zinc > aluminum > carbon steel > copper > stainless > gold** (very roughly, from most active/anodic to most noble/cathodic).

- *Crevice vs. Pitting:* Don't confuse these. **Pitting** can occur on a free open surface (just needs a local film break and aggressive ions), whereas **crevice corrosion** specifically involves a sheltered area. On the exam, if they mention a gasket, bolted joint, or trapped fluid, think crevice. If they mention "small deep holes on a surface" with no mention of a physical crevice, think pitting (often in stainless or Al in chloride environment).

- *Stress-Corrosion Cracking Note:* SCC requires both stress and corrosion. No tensile stress, no SCC. Likewise, if the environment is not one known to cause SCC in that material, it won't happen. Exam questions might describe a scenario of a stressed part in a specific chemical (like "caustic embrittlement" of steel in alkaline water or chloride-induced cracking) – the key is recognizing the combo. Remember, pure mechanical overload or fatigue is different; SCC involves a corrosive agent enabling cracks at lower stress.

Variations and Related Forms: Other corrosion mechanisms exist (beyond the core list above), and it's good to be aware of the terminology. For instance, **Intergranular Corrosion** targets grain boundaries (e.g. sensitized stainless steel can corrode along grain boundaries after improper heat treatment), and **Erosion–Corrosion** happens when fluid flow or particles wear away the protective film, accelerating corrosion (like pipe elbows experiencing both corrosion and abrasion). These specific forms are less commonly tested, but they underline an important idea: corrosion can combine with other factors (microstructure, velocity, etc.). Always consider if the problem scenario hints at something beyond plain uniform rust.

Explanation & Analysis: Corrosion mechanisms can be identified by the **pattern of damage and the conditions**. Here's how to analyze a situation on the FE exam:

Uniform corrosion is straightforward: look for general surface thinning, dulling, or extensive rust. The exam might imply it with

something like "a steel tank uniformly thinned after years in service." If no specific local factors are mentioned, **assume uniform attack**. The "fix" for uniform corrosion is usually choosing a more corrosion-resistant material or adding a protective coating (since the whole surface is vulnerable).

Galvanic corrosion requires at least two different metals in contact in a conductive fluid. An exam question might describe, for example, copper tubing connected to a steel fitting in saltwater. Your thought process: *two metals + electrolyte = galvanic cell*. Determine which metal is the **anode** (the one that will corrode): the more active metal (often the one that's *less* "noble"). In the copper-steel example, steel is less noble than copper, so the steel will corrode. **Key observation:** The corroding metal often shows heavy attack near the junction, while the other metal remains intact or just gets surface deposits. Remember that **physical size ratio matters**: a **small anodic part with a big cathodic part** is a worst-case galvanic scenario (tiny anode dissolves fast to feed electrons to the large cathode area). The exam might test this concept by asking which configuration is more corrosive or how to minimize galvanic corrosion (answer: use metals close together in galvanic series, insulate them, or ensure the anode is large relative to cathode).

Pitting will be implied by keywords like "localized holes" or a description like "surface is shiny except for a few small deep cavities." It's especially associated with passive metals in specific environments (e.g. stainless steel in presence of chlorides like seawater or bleach). Pitting is essentially a local breakdown of a protective film – once a pit initiates, the chemistry inside the pit (acidic, chloride-rich) makes it self-sustain and deepen. On a question, if they mention a stainless steel tank or aluminum component that unexpectedly developed leaks or pinpoint corrosion, **think pitting**. It often occurs in stagnant conditions; interestingly, a bit of fluid motion can actually help by bringing oxygen to re-passivate the surface – stagnant crevices or under deposits are worst.

Crevice corrosion clues are any mention of a tight gap or sheltered area: "under the gasket," "between two overlapping plates," "beneath deposits or biofilms." The mechanism is usually differential aeration: the hidden area gets oxygen-starved and becomes anodic relative to the outside. So you might see a question where a stainless steel bolt and washer assembly corrodes heavily under the washer – that's crevice corrosion (even though stainless is generally corrosion-resistant, the lack of oxygen under the washer prevents it from maintaining its protective oxide). In analysis, crevice corrosion is very similar to pitting in its chemistry (developing an aggressive microenvironment), but you know **where** it will happen (any crevice or stagnant zone). **Design strategy:** remove or seal crevices, use welds instead of riveted lap joints, etc., or use gaskets that won't trap fluid.

Stress-corrosion cracking (SCC) requires interpreting both **material stress** and **environment** from the problem statement. For example, they might describe a high-strength steel bolt in a tensile application that fractured unexpectedly, and note the presence of a specific chemical (like a high-pH caustic solution, or just "in service for years in a corrosive environment"). The giveaway is often *cracks* with little overall corrosion. In analysis, if you identify SCC, you know the remedy involves reducing stress (e.g. stress relief anneal, design with lower stress) or changing the environment/material (use a grade not susceptible to that environment, add inhibitors, etc.). SCC is very specific: not every metal will crack in every environment. The FE won't expect you to know exotic combinations, but a classic one is **chloride-induced SCC in stainless steel** or **caustic cracking in carbon steel**. If the question mentions those, that's your cue. A prevention question might then ask "how to avoid it?" – likely answers: lower the stress, remove the chemical agent (like control water chemistry), or select a different material that doesn't crack in that environment.

K09.T09.S02 – Electrochemical Nature of Corrosion

Principle Introduction: Corrosion is fundamentally an **electrochemical process**. This means it's essentially a **tiny battery or galvanic cell** operating on a metal's surface. Key points to remember:

Anode and Cathode: In any corrosion scenario, some site on the metal acts as the **anode** (metal atoms oxidize to ions, releasing electrons) and another site acts as the **cathode** (consuming those electrons via a reduction reaction). *The anode is where the metal corrodes (material loss occurs), while the cathode site stays intact.* Even on a single piece of metal, you can have microscopic anodes and cathodes if conditions vary across the surface.

Electrolyte: For the corrosion cell to function, the anode and cathode must be connected by a **conductive medium** – typically an electrolyte (like water with dissolved ions, e.g. saltwater, moist soil, or even just humid air with a thin water film). The electrolyte allows **ionic current** to flow (balance charge by moving ions), while the metal itself (or an electrical connection) allows **electronic current** (flow of electrons) between anode and cathode. Remove the electrolyte (e.g., keep the metal **dry**) and you break the circuit – corrosion slows to a crawl or stops.

Potential Differences: The driving force for corrosion is the potential (**voltage**) difference between the anodic and cathodic reactions. Different metals (or different areas on one metal) have different natural potentials. The **anode** is the one with a more negative (or lower) potential relative to the cathode in that environment, causing electrons to flow from anode to cathode. You might recall the concept of a **galvanic series**: a ranking of materials in a given environment (like seawater) from most active (anodic) to most noble (cathodic). In a galvanic couple, the metal higher in the series (more active) will be the anode and corrode.

Half-Reactions: At the **anode**, a typical half-reaction is **metal oxidation**: for example, $\mathrm{Fe} \rightarrow \mathrm{Fe}^{2+} + 2\,e^{-}$. Metal atoms leave as positive ions, freeing electrons. Those electrons travel to the **cathode**, where a **reduction reaction** takes them up. Common cathodic half-reactions in corrosion are reduction of dissolved oxygen or water: e.g. $\frac{1}{2}\,\mathrm{O}_2 + \mathrm{H}_2\mathrm{O} + 2\,e^{-} \rightarrow 2\,\mathrm{OH}^{-}$ in a neutral or basic solution (oxygen reduction forming hydroxide), or $2\,\mathrm{H}^{+} + 2\,e^{-} \rightarrow \mathrm{H}_2 \uparrow$ in an acidic solution (hydrogen evolution as bubbles of H_2 gas). The specifics depend on the environment's chemistry (pH, oxygen availability). But **you don't need to memorize these equations** for the FE – just know that electrons must be consumed by some reduction process at the cathode.

Corrosion Products: After the metal ions form, they often react further in the electrolyte to form solid corrosion products (like rust, $\mathrm{Fe}_2\mathrm{O}_3$ or $\mathrm{Fe}_3\mathrm{O}_4$, in the case of iron). These may deposit near the anode. Sometimes corrosion products form a **protective film** that slows corrosion (as with aluminum or zinc oxides), and other times they form a flaky layer that doesn't protect (as with rust on steel, which can fall off and expose fresh metal).

Exam Handbook Search Cues (Not affiliated with or endorsed by NCEES): anode; cathode; oxidation; reduction; corrosion cell; galvanic series; standard electrode potential; Faraday constant

Footnotes:

- *Remember the Roles:* **Anode = oxidation = metal loss. Cathode = reduction = no metal loss at that site.** A common point of confusion is thinking "cathode = positive electrode" and "anode = negative" in corrosion. In a spontaneous corrosion cell, the **anode is negatively charged** relative to the cathode *because* it supplies electrons (it's like the negative terminal of a battery), but it's also the one that dissolves. So don't equate "anode" with "positive" in the context of corrosion. Instead, equate anode with **active metal** and corrosion.

- *Electrolyte Clue:* If an exam question mentions that a joint is kept **dry** or coated, it implies the electrolyte is removed and galvanic corrosion will be minimal. Corrosion rate in general **skyrockets in the presence of water** (especially saltwater which is a strong electrolyte). Pure water itself is a weak electrolyte, but with a bit of dissolved ions (like CO_2 making carbonic acid, or salts) it becomes aggressive. Humidity and thin films can be enough electrolyte in some cases (e.g., rusting of iron in humid air).

- *Galvanic Series vs Standard Potentials:* You might recall **Standard Reduction Potentials** from chemistry (voltage values in a table for half-reactions). The exam **Reference Handbook** includes a table of "Standard oxidation potentials for corrosion reactions" – essentially an electrode potential list. While you won't likely do calculations with those, qualitatively they tell you which metals like to oxidize (negative potentials) and which resist oxidation (positive potentials). The **Galvanic series** is a practical incarnation of that concept, measured in specific environments. For instance, in seawater: magnesium, zinc, and aluminum sit at the active (anodic) end; gold, graphite, platinum at the noble (cathodic) end. **Exam tip:** If asked which metal in a pair corrodes, think of which is "closer to magnesium" vs "closer to gold" in activity. The one more like magnesium (active) will be the sacrificial one.

- *Internal Anodes and Cathodes:* A single piece of metal can corrode by itself if it develops anodic and cathodic regions. How? If parts of the surface experience different conditions. **Examples:** A steel pipe half buried in soil and half exposed to air – the buried portion might be anodic relative to the above-ground part (different oxygen levels). Or even microscopic differences: **cold-worked** (strain-hardened) areas of a metal can become anodic relative to unstressed areas, because cold working can increase stored energy and alter the electrode potential slightly. **Implication:** Non-uniformities (composition, stress, oxygen access) can create mini corrosion cells on one metal. This explains phenomena like weld decay (zones around welds corroding due to microstructural changes) or why the center of a rust patch can be different from the edges.

- *Breaking the Circuit:* Because corrosion is an electrochemical circuit, designers mitigate corrosion by **breaking the circuit**. Coatings insulate the metal from electrolyte (no ionic path), cathodic protection supplies external electrons (so the metal doesn't have to corrode to provide them), and isolating dissimilar metals (with insulating spacers) breaks the metallic contact for electron flow. We'll discuss these methods next, but always tie it back to this principle: **no anode-cathode-electrolyte loop, no corrosion current**.

Equation Passport: Faraday's Law of Electrolysis – relates electric charge to the amount of material corroded (or deposited). This equation quantifies how much metal will dissolve given a certain flow of electric charge in a corrosion or plating process. While many FE corrosion questions are conceptual, if you ever need to calculate **mass loss** from corrosion current or vice-versa, Faraday's law is your tool.

Equation:

$$m = \frac{Q\ M}{F\ z}$$

where:

- m = mass of metal oxidized (corroded) or reduced (plated), in **grams**
- Q = total electric charge that has flowed (current × time), in **coulombs** (C)
- M = molar mass of the metal (atomic weight), in **g/mol**
- F = Faraday's constant = 96,485 C/mol (the charge of one mole of electrons)
- z = valence number of metal in the oxidation reaction (number of electrons transferred per atom oxidized)

Assumptions & Scope:

- This relationship assumes **100% current efficiency** for the metal's corrosion reaction – i.e. all the electric charge goes into oxidizing metal (or plating metal) with no side reactions. In real corrosion, some current might go into other reactions (like other metals corroding or different reductions), but on exam problems it's usually implied to use the ideal case.

- The metal's oxidation state change is known and constant (that's your z). For example, if iron is going from Fe to Fe^{2+}, $z = 2$. If a metal can have multiple oxidation states, use the one relevant to the problem (they should tell you, e.g. "iron(II) ions form" or give enough context).

- *Unit consistency:* If using this formula, ensure you convert time to seconds for Q (since Q in coulombs = current in A × time in seconds). This formula is built on SI units. Molar mass in g/mol and Faraday's constant in C/mol will yield m in grams.

Limit tests (sanity checks): If no charge flows ($Q \to 0$), obviously no mass is lost ($m \to 0$). This makes sense: no current, no corrosion. If a huge amount of charge flows, the mass lost grows **linearly** with Q – double the coulombs, double the metal consumed. This linear proportionality can help catch mistakes: if you inadvertently divide when you should multiply, your answers will be off by a factor related to those variables, so a quick mental check "more current or time means more corrosion" should hold true.

Use vs. Sibling Equations: Use Faraday's law instead of vague reasoning whenever you see a problem quantifying **corrosion rate, mass loss, or electroplating** over time with a given current. It is essentially a stoichiometric conversion between electrical charge and moles of metal. There isn't a direct "competing" formula at the FE Mechanical level – just remember this one if needed, rather than trying to derive from scratch under pressure. (Don't confuse this with equations for electrical induction also called "Faraday's law" in physics – context here is electrochemistry.)

Common exam traps:

- **Forgetting time units:** If a problem gives current in A and time in hours, convert time to seconds to get Q in coulombs. A very common mistake is to plug in hours directly. For example, 2 A for 1 hour is $Q = 2 \times 3600 = 7200$ C, not 2 C.

- **Mixing up M (molar mass) and m (mass).** It's easy to plug in atomic weight in kg or grams incorrectly. Stick to grams/mol for M and the answer for m will come out in grams. If they want weight in, say, kilograms, convert at the end.

- **Wrong valence (z):** Pay attention to the reaction. If the problem says "iron(III) oxide forms" or mentions Fe^{3+}, then $z = 3$ for each Fe atom oxidized. If it's forming Fe^{2+} (like in some corrosion processes), $z = 2$. Similarly, for copper going to Cu^{2+}, $z = 2$. This can be a subtle detail in wording.

- **Sign confusion:** Faraday's formula as given is using magnitudes (mass and charge). Don't worry about positive/negative sign of charge or electrons for this calculation – just use the total charge passed. A question might give a current and ask how much of a metal dissolves (corrosion is effectively a **positive mass loss** from the material). Just compute m and understand that means that many grams *left* the metal. If asked how many grams of a certain metal would plate out onto a cathode, you'd compute similarly (the same formula applies to deposition), but conceptually that mass is gained at the cathode.

Explanation & Analysis: Understanding corrosion as an electrochemical cell helps you reason through how to **stop or reduce corrosion** and also to predict what happens in different scenarios:

- **Need all three components:** anode, cathode, electrolyte. If any one is eliminated or significantly hindered, corrosion slows dramatically. For instance, without an electrolyte (say the metal is in fully dry air), the circuit is incomplete – metals might tarnish slowly by direct oxidation, but you won't get the rapid, continuous corrosion you see in water. Likewise, if you somehow prevent either the anodic or cathodic reaction from occurring (maybe by inhibitors that raise the energy barrier), corrosion current drops.
- **Anode vs Cathode areas:** The relative **area** of anode and cathode surfaces is crucial. If you have a small anode area supplying electrons to a large cathode area, the current per unit area on the anode is very high – meaning intense corrosion focused on that small anode. Conversely, a large anode paired to a small cathode spreads out the corrosion, slowing the attack rate at any given point (this is why, for example, big zinc plates can protect a small steel part effectively – the zinc corrodes slowly over a large area to feed a tiny cathode area). On exam questions dealing with galvanic corrosion, keep an eye on the area ratio if they mention sizes or surface areas.
- **Electrode potentials in practice:** If needed, you can think of the standard potential table as a ranking: each metal has a tendency to shed electrons (oxidize) or accept electrons (reduce). **Zinc** has a standard reduction potential around –0.76 V (Zn^{2+}/Zn), whereas **copper** has +0.34 V (Cu^{2+}/Cu). When you connect Zn and Cu in a cell, the difference is about 1.1 V, and Zn (lower potential) will oxidize (it acts as the anode). **Magnesium** is even more active (~–2.37 V for Mg^{2+}/Mg), so it will beat zinc in an electron-giving contest. You won't have to calculate these voltages on the FE, but the idea is: the larger the potential difference between anode and cathode, the stronger the driving force and often the faster the corrosion (all else equal). However, corrosion rate is also controlled by other factors like how fast the cathodic reaction can proceed (often limited by oxygen diffusion in solution). A practical upshot: even a pretty active metal won't corrode too fast if the cathode reaction (like oxygen reduction) is slow due to low oxygen supply. This is why corrosion in deaerated (oxygen-free) water is much slower – the cathodic reaction is bottlenecked.
- **Local corrosion cells:** Realize that **even a single type of metal** can corrode by forming anodic and cathodic regions. Impurities, grain orientations, or differential oxygen access set up tiny potential differences. For example, iron under a droplet of water will often corrode more in the center of the droplet (anodic area, oxygen low) while the edge of the droplet where oxygen diffuses in becomes cathodic. This yields the classic pattern of a rust ring around a relatively less corroded center. On the exam, they likely won't dive into this level of detail, but it reinforces why design details (like avoiding trapped moisture spots) matter.
- **Calculations using Faraday's law:** If faced with a numerical corrosion question, it might be something like: "A current of 1.5 A is observed from a corroding iron sample over 10 minutes. How many milligrams of iron have dissolved? (Assume iron dissolves as Fe^{2+})." To solve: first get total charge $Q = 1.5\ \text{A} \times 600\ \text{s} = 900$ C. Iron Fe → Fe^{2+} means $z = 2$ electrons per atom. Molar mass of Fe is about 55.85 g. Plug in: $m = \frac{900 \times 55.85}{96485 \times 2} \approx 0.26\ \text{g} = 260$ mg. That's the kind of straightforward use of Faraday's law that could appear. Another angle: maybe they give you mass lost and time, and ask for the corrosion current or current density – same formula rearranged. The key is recognizing when to use it (look for mention of **current or charge** related to corrosion or plating).
- **Big picture:** The electrochemical view is powerful because it explains **why** certain methods of corrosion control work. The next section will explore those methods, but as a preview: if you want to **stop corrosion**, you either prevent the anodic reaction (make the metal immune to oxidation), prevent the cathodic reaction (maybe by removing oxygen or adding inhibitors), or cut the connection (dry it out, insulate metals, etc.), or even **provide a better anode** (sacrificial metal) so your structure becomes the cathode. All strategies map to manipulating the electrochemical circuit we just discussed.

K09.T09.S03 – Methods of Corrosion Control

Principle Introduction: Since corrosion is a controllable electrochemical process, engineers use a **toolbox of methods** to combat it. Think of each method as targeting a part of the corrosion cell or its driving forces. The main categories of corrosion control to know:

- **Material Selection (Corrosion-Resistant Alloys or Materials):** The simplest strategy is often **choosing a material that doesn't corrode easily** in the given environment. For example, use stainless steel instead of plain steel in a marine environment, or use brass or plastic for fittings in a corrosive water system. Some

materials **self-protect** by forming a stable oxide layer (like the chromium oxide on stainless steel, or aluminum's oxide film). Material compatibility is key: pick metals or materials known to resist the chemicals and conditions they'll see.

- **Protective Coatings and Plating:** This involves **isolating the metal from the environment** with a barrier. Paints, epoxy coatings, polymer linings, ceramic coatings, or metallic platings (like plating steel with zinc, nickel, or chrome) all fall here. A good coating keeps the electrolyte and oxygen away from the metal surface so the corrosion cell can't get started. Even something like grease or oil can act as a temporary corrosion preventive coating (keeping water off the surface). On exam day, if you see a reference to "apply a protective layer" or a specific coating like **galvanizing**, that's this category.
- **Cathodic Protection:** A more electrochemical approach – here we **force the metal to be the cathode** in any corrosion cell, so it **will not corrode** (since by definition, corrosion happens at the anode). We do this by supplying external electrons to the structure: either by attaching a **sacrificial anode** (a piece of a more active metal that will corrode in place of the structure) or by using an **impressed current** from a DC power source to push electrons onto the structure. This method is common for pipelines, ship hulls, underground tanks, etc.
- **Environmental Modification:** If you can't change the material or add coatings, sometimes you can change the environment to be less corrosive. This might mean **adding corrosion inhibitors** (chemicals that slow corrosion reactions, like oxygen scavengers in boiler water or passivating inhibitors that form films), **reducing exposure** to corrosive agents (dehumidify air, remove oxygen or chlorides from a system), or controlling temperature/pH. Often in the field, water chemistry is tightly controlled to prevent corrosion. While this is more of a chemistry control approach, it's good to recall that the environment is part of the corrosion equation.
- **Design and Geometric Considerations:** Good design can eliminate a lot of corrosion risk. This includes avoiding **crevices** where water can stagnate, designing for drainage (no water traps), avoiding sharp changes that concentrate corrosion, and **isolating dissimilar metals** (using insulating sleeves or gaskets to break galvanic contact). Also, making anode areas larger relative to cathodes (if a galvanic couple is unavoidable) can reduce damage. Structural overdesign (adding corrosion allowance thickness) is another form of mitigation – accepting some corrosion will happen but planning for it.

Exam Handbook Search Cues (Not affiliated with or endorsed by NCEES): corrosion protection; coatings; galvanizing; sacrificial anode; cathodic protection; corrosion inhibitor; material selection

Footnotes:

- *Galvanizing:* A term you should know – **galvanized steel** means steel that's been coated with zinc (usually by hot-dip process). This is a double bonus: the zinc coating acts as a **barrier** and, if scratched, the exposed zinc serves as a **sacrificial anode** to protect the steel (zinc will corrode, not the steel). It's a favorite method for outdoor corrosion protection (think highway guardrails, lamp posts, etc.). On an exam question, if an answer choice says "galvanize the steel component," that's often correct for corrosion protection. - *Coatings Caveat:* A perfect coating is great, but one **tiny defect** can be problematic. If a coating has a pinhole, you can get a very aggressive localized corrosion at that spot: the small exposed metal area becomes anodic and the large coated area around it acts as a cathode (since it stays intact and oxygen can reach the coating edges). This is why coatings are often used in combination with cathodic protection or inhibitors, especially for critical systems: just in case there's a defect, the other method will suppress corrosion.

- *Sacrificial vs Impressed Current:* Know the difference. **Sacrificial anode** method: you bolt on pieces of a more active metal (e.g. magnesium anodes on a steel pipeline or hull). These anodes naturally produce a current by corroding themselves and thereby protect the structure (which becomes cathodic). No external power needed, but you do have to replace the anodes periodically as they get consumed. **Impressed current** method: you use an inert anode (like a titanium mesh or silicon iron rod) and hook it up to a DC power source (like a rectifier) with the structure as the cathode. By controlling the current, you force the structure to stay cathodic. The inert anode may slowly corrode or wear, but much more slowly, and the system can protect large structures (like long pipelines) with fewer anodes. The exam might not delve deep into this, but you should at least recognize that impressed current systems exist for cases where sacrificial anodes aren't practical (due to size/current requirements).

- *Material Selection Nuance:* "Corrosion-resistant" is relative to the environment. Stainless steel is great in many cases, but put basic 304 stainless in chlorine-rich water and it can pit like crazy. Aluminum is generally very resistant due to its oxide film, but put it in a strong alkali (high pH) and that film dissolves and the aluminum will corrode (also aluminum in contact with concrete can be bad due to the alkaline cement pore water). The exam likely won't quiz these specific combos, but if they describe a scenario where a normally good material is failing, check if the environment is one of its few Achilles' heels. Conversely, a material like **Titanium** is highly corrosion resistant in most environments (thanks to a robust oxide film) – it's overkill for many applications, but an exam question might have it as an option in a list of materials and you should recognize it as extremely corrosion resistant (and expensive, usually).

- *Cost vs Benefit:* Sometimes a question might be conceptual around economics of corrosion control – e.g., "What's the most cost-effective corrosion control for a buried steel pipeline?" Typical answer: **cathodic protection** plus coating. Coatings reduce the area that needs protection; cathodic protection handles any exposed spots. Material selection (using stainless for a huge pipeline) would be far too costly, and relying on inhibitors alone in soil isn't feasible, so the combined method is the industry standard. Keep in mind practical implications: coatings are cheap per area, cathodic protection is manageable, but exotic alloys are costly, so they're used where justified (like in very high temperature or highly corrosive chemical service where nothing else works).

Definition Passport: Cathodic Protection

- **Plain-language definition:** *Cathodic protection* is a technique to prevent metal corrosion by turning the entire metal structure into a **cathode** in an electrochemical cell. Since corrosion (metal loss) happens at the anode, making your structure the cathode means it **won't corrode** – instead, some other sacrifice is made to supply the necessary electrons.

- **Where it matters (exam impact):** This concept appears in questions about **protecting pipelines, tanks, or marine structures**. For example, they may ask what method is best to prevent corrosion of an underground steel tank – cathodic protection with sacrificial anodes or impressed current is the

answer. They might also expect you to identify a sacrificial anode material (e.g. using magnesium anodes to protect a steel pipeline).

- **Pitfall or confusion point:** Don't confuse *cathodic* vs *anodic* protection. Cathodic protection is the common one (supply electrons to the structure). Anodic protection is a different, less common method used in specific industrial cases (it deliberately maintains a metal as an anode but under controlled conditions to form a passive film – typically for extremely corrosive acids and only works for certain metals like stainless steel in sulfuric acid). The FE Exam is almost certainly referring to *cathodic* protection when it mentions corrosion control. Another point: ensure you pick the **more active (more anodic) metal** as the sacrificial anode. A common mistake is to choose a noble metal by mistake – e.g., *attaching copper to steel would actually make the steel corrode more*, not protect it, because steel is more active than copper. Always select a sacrificial metal that sits **below** (more active than) the protected metal in the galvanic series.

- **Micro-check:** *True/False:* To protect an iron (steel) structure in seawater using sacrificial anodes, **aluminum** would be a better choice than **gold**. (Think about which one is more active relative to iron – the "more active" metal is needed as the anode. Gold is extremely noble, so it wouldn't sacrifice itself; aluminum is much more active and thus a suitable anode material to protect iron.)

Variations and Related Forms: The other methods of corrosion control often complement each other. It's common to use **multiple strategies in combination**: e.g., coat a steel structure *and* use cathodic protection as backup, or use a corrosion inhibitor *and* pick a better alloy. Also, note the existence of **anodic protection** (mentioned above) – that's really a niche technique (likely outside FE scope) where you apply a tiny anodic current to keep a metal in a passive state (it forms a protective oxide film and stays there). It only works for certain metal-environment combos (like some stainless steels in acid). Just be aware that the word exists so you don't get thrown off if you see it, but cathodic protection is the go-to answer unless they specifically describe the passive-film situation.

Another related concept: **passivation** – using the environment or chemical treatment to induce a protective oxide film on the metal. For example, exposing stainless steel to air allows it to **passivate** (form Cr_2O_3 film). Sometimes inhibitors in solution work by promoting passivation. This isn't a separate "method" you actively apply (except in cases like applying a chemical oxidizer to force a film), but it underpins why some materials resist corrosion. The exam might not mention "passivation" explicitly, but if you know the term, it can clarify why alloys like chrome steels or aluminum don't corrode much: they **auto-protect** by forming a thin, adherent oxide layer. Just remember that **if that film is damaged or the environment prevents it from forming (low oxygen, or the film is attacked by chlorides), corrosion can still occur**.

Special Notes – Calculators: If you encounter a calculation involving corrosion rate or amount (e.g. using Faraday's law), you'll likely need to do unit conversions. On your FE-approved calculator, make use of the memory or multi-step operations: for instance, computing $m = QM/(Fz)$, you can input as Q * M / (96485 * z). Keep track of significant figures if the question cares, but usually a reasonable rounding is fine. Most importantly, double-check that time is in seconds and charge in coulombs if you're doing a Faraday's law calc – a quick mental approximation can save you from a factor of 3600 error. Also, be mindful of units if the question gives a corrosion **rate** like mm/year or mils/year – converting between metrics (25.4 micrometers per mil, etc.) might be necessary but they might avoid that depth.

Explanation & Analysis: Let's break down how each corrosion control method actually interrupts the corrosion process (and how to recognize it in problem-solving):

Material Selection: This is about choosing a material that either (a) **forms a stable protective film** or (b) is inherently **unreactive** in the environment. For example, in a high-temperature oxidizing environment, you'd select a nickel-chromium alloy or stainless steel that can handle scaling, rather than plain carbon steel. In a chemical plant handling acid, you might use a grade of stainless, a nickel alloy, or even a plastic like Teflon, depending on what resists that acid. On the exam, if they ask something like "how to prevent corrosion of a component in a mildly corrosive environment without coatings," the answer could be "use a more corrosion resistant alloy." Just be cautious: sometimes the *most* corrosion-proof materials (titanium, Hastelloy, etc.) are expensive, so in practice they're used only when needed. But exam questions might not delve into cost considerations unless explicitly stated. A subtle consideration: **material compatibility** goes beyond metals – sometimes the right answer is "use a nonmetallic material" (e.g., PVC piping instead of steel for certain chemicals). Nonmetals like plastics and ceramics don't corrode electrochemically (they have other failure modes, but not galvanic rust). If you see options that include using a polymer or composite in a harsh chemical environment, that's often a good choice because they can be immune to typical corrosion (just ensure they can handle temperature and mechanical needs).

Protective Coatings: Coatings work by **keeping the electrolyte away** from the metal. Paints, powder coatings, epoxies, and enamels are common. Metallic coatings like chrome plating or nickel plating also serve as a barrier (though if those metals are noble compared to the substrate, any break in the coating can cause galvanic attack of the substrate as mentioned). A key word to look for is **"barrier"** or **"seal."** If a question asks how to protect something and one of the answers is "apply an epoxy coating" or "paint it," that's a valid method for many situations. The effectiveness of a coating depends on adhesion and integrity: if it sticks well and doesn't crack, you've essentially removed the electrolyte from the equation. Some coatings also incorporate **inhibitors** (like zinc-rich paint, which has powdery zinc that can provide sacrificial properties akin to galvanizing, or chromate pigments that inhibit corrosion at scratches). For FE purposes, just know coatings are first-line defense for many structures (low cost, easy to apply). If a scenario involves concrete or rebar: **epoxy-coated rebar** is a thing to prevent rebar corrosion in concrete (they coat the steel rebar with epoxy). If they mention it, realize it's a barrier method.

Cathodic Protection: The analysis here is directly tied to the electrochemical basics. By making your structure a cathode, you ensure no anodic metal dissolution happens on it. How do we supply electrons? If using a **sacrificial anode**, you attach pieces of a more anodic metal. For example, magnesium anodes on a steel pipeline: Mg wants to corrode (anodic) and will generate a current that flows through the soil (electrolyte) into the steel, effectively **pushing electrons into the steel**. The whole steel pipeline becomes cathodic (it might even develop a slight negative potential). The magnesium slowly dissolves into Mg^{2+} ions over time. In **impressed current**, you force electrons in from an external DC source: typically, you bury some inert anode (like a graphite or mixed-metal rod) in the ground near the structure and connect it to the positive terminal of a DC supply, and connect the structure to the negative terminal. When current flows, electrons go from the power supply into the structure (negative side) and then out from the structure through the electrolyte to the anode, completing the

circuit. The structure again is cathodic and safe, while the inert anode might experience some oxygen evolution or minimal wear. *For exam analysis:* Identify if the problem hints at using sacrificial metal pieces or a power source. If they say "a magnesium rod is connected to the tank," they are describing sacrificial anode CP. If they mention "a rectifier and an impressed current system," they mean the other type. Typically, FE exam won't get too deep, but know that **magnesium, zinc, aluminum** are common sacrificial anodes (magnesium being most active, used in soil and freshwater; zinc/aluminum often in seawater). If asked "which metal would you use to protect an underground iron pipeline via sacrificial anode," pick one of those more active metals (Mg is a common choice underground due to driving voltage).

Environmental Modification: While less likely to be the *only* answer (unless the question is specifically about chemistry), consider if the scenario allows for **changing the environment**. For example, in a closed-loop cooling system, adding a corrosion inhibitor (like a phosphate or nitrite) could be a solution. If the question is like "how to reduce corrosion in a boiler or cooling system," the answer might be "add oxygen scavenger chemicals (to remove dissolved O_2)" or "increase pH to reduce acidity" or "use an corrosion-inhibiting additive." If it's about atmospheric corrosion, maybe the answer is "reduce humidity" or "control the environment (dehumidify, inert gas purge in storage)." Also, **cathodic vs anodic inhibitors**: some chemicals work by precipitating on cathodes and slowing the cathodic reaction, others by complexing with metal ions at anodes. You won't need those details, just the concept that inhibitors can slow corrosion by interfering with the reactions.

Design Strategies: Always consider if the problem hints that a design tweak could fix the issue. If a question describes, say, bolts corroding in a flange, maybe the real solution is "use insulating washers to separate the dissimilar metals" or "avoid having that crevice by welding instead." If they mention "differential metals in contact," an answer could be "electrically isolate the metals." If they talk about a geometry that traps water, the fix could be "provide drainage or ventilation to eliminate stagnant moisture." These are *engineering judgment* answers – not equations, but practical fixes. For the FE, these are usually straightforward: e.g., if galvanic corrosion is the issue, either separate the metals or pick closer metals; if crevice corrosion is an issue, eliminate the crevice or use a gasket that seals out water completely; if something is cracking from SCC, maybe redesign to lower stress or remove the corrosive agent (like stress-relieve the part and keep chlorides away).

Combining methods in analysis: In real applications, multiple methods are combined for robust corrosion control. The exam might indirectly test this by offering multiple viable answers – e.g. "use a more resistant alloy" vs "coat the existing alloy." In such cases, consider context and cost: coatings are cheap and often a first measure; a more exotic alloy might be second resort unless the environment absolutely requires it. However, if the question is specific (like "the component must be maintenance-free for 30 years in seawater"), then using a corrosion-resistant alloy or a thick hot-dip galvanized coating might be the intended answer over just painting it. Pay attention to wording like "most effective long-term solution" vs "most cost-effective solution." They might differentiate answers that way.

Monitoring and maintenance: Not typically on the exam, but just to round out your understanding: even with all these measures, engineers often implement monitoring (like corrosion coupons, probes, routine inspections) and maintenance (repainting, replacing anodes) to manage corrosion over a structure's life. So corrosion control is an ongoing process, not a one-and-done decision. For FE purposes, though, your task is to pick which method or combo makes sense given the scenario and options provided.

K09.T09.S04 – Environmental Effects and Material Compatibility

Principle Introduction: The **environment** in which a material operates can make or break its corrosion performance. Even the best alloy can fail if put in the wrong environment. This subtopic is about understanding how different conditions (chemical exposure, temperature, etc.) affect corrosion, and how we select materials that are **compatible** with those conditions:

Chemical Environment: Consider the chemicals (liquids, gases) that a material will touch. Acids, bases, salts, water, oxygen – each interacts differently with materials. For example, steel corrodes rapidly in acidic environments or saltwater, but might do fine in oils or dry air. Some plastics might be great in water but dissolve in organic solvents. **Material compatibility charts** (like the one in engineering handbooks) list how well materials resist various chemicals. *Exam-wise:* If a question says a component is used in a certain chemical service (like "concentrated hydrochloric acid" or "high-purity water"), you should recall or deduce which materials stand up to that. HCl acid, for instance, attacks many metals (even stainless steel) – materials like special alloys (Hastelloy) or certain plastics (Teflon, PVC) are preferred. High-purity water actually can be surprisingly aggressive to steel (low ions means water wants to leach metal ions). The key is to pair the environment with a material known to handle it.

Galvanic Compatibility: When different metals share an environment, the environment's conductivity and corrosiveness determine if galvanic corrosion is a concern. **Dry air**: you can bolt copper and aluminum and they'll be mostly fine (no electrolyte). **Humid or wet**: galvanic corrosion becomes a risk. Saltwater or marine atmosphere: galvanic corrosion risk is **high** (saltwater is a strong electrolyte). Thus, the environment dictates whether you need to worry about mixing metals. Similarly, temperature can affect galvanic behavior slightly (but conductivity of electrolyte and corrosion kinetics generally increase with temperature).

Temperature and High-Temperature Oxidation: At elevated temperatures (think hundreds of °C), metals can oxidize even without liquid electrolytes – they literally react with oxygen or other gases. This is usually called **high-temperature corrosion or scaling** rather than ordinary "rust." For example, steel will form iron oxide scale in a furnace; if the scale flakes off, fresh metal keeps oxidizing. Materials like stainless steels, chromium alloys, and aluminized steels form more adherent oxides that protect better at high T. There are also phenomena like **hot corrosion** where sulfate salts can deposit and cause aggressive attack in turbines. For FE exam, the main point is: **for high-temperature service, choose materials specifically rated for those temperatures** (stainless, Inconel, ceramics, etc.) because regular carbon steel will oxidize and weaken. And conversely, some materials (and coatings) that work great at room temperature may degrade at high T. Paint, for instance, burns off or deteriorates if too hot, so you might need special high-temp coatings or alloy solutions.

Stress and Environment Synergy: We discussed stress-corrosion cracking in subtopic S01, which is a prime example of environment-specific material failure. Another is **corrosion fatigue** – a material might endure a certain cyclic stress for millions of cycles in air, but if you add a corrosive environment, cracks

nucleate easier and grow faster, drastically reducing fatigue life. The exam could indirectly reference this: e.g., "a shaft in a corrosive environment fails at a lower stress than expected." The takeaway is that environment can lower the threshold for other failure modes.

Regulatory/Compatibility considerations: In some cases (likely beyond FE scope, but just context), certain environments require not only corrosion resistance but also avoiding contamination. For example, in the food industry or biomedical applications, stainless steel is used not just because it resists corrosion, but because if it did corrode it could contaminate the product. Or certain water systems use specific materials to avoid heavy metal leaching (lead, copper). So "material compatibility" is about chemical interaction in both directions. For exam purposes, focus on the corrosion aspect (will the material hold up), but it's good to recall that sometimes the question might be framed as "which material is suitable (from a corrosion/compatibility standpoint) for this application."

Exam Handbook Search Cues (Not affiliated with or endorsed by NCEES): material compatibility; corrosion rate; oxidation; high-temperature oxidation; noble metals; inert material; environment; galvanic compatibility

Footnotes:

- *Protective Oxide Films:* Some metals **oxidize a little to avoid oxidizing a lot** – that's passivation. Aluminum, chromium (stainless steel), titanium, and zinc are notable examples. Aluminum exposed to air forms Al_2O_3 almost immediately as a tight thin film – that's why aluminum doesn't "rust through" like iron; the oxide sticks well and blocks further corrosion. Chromium in stainless does similar (Cr_2O_3 film). However, **chloride ions** are the nemesis of these passive films – they can penetrate or prevent film formation, causing pitting. So even the best alloys (like high-grade stainless) can suffer in concentrated chlorides or bleach. Always consider if the environment contains something that attacks the protective film. For instance, **stainless steel in seawater** – 304 stainless might pit, whereas a more alloyed version like 316 (with molybdenum) is better but still not perfect in warm seawater; super duplex or titanium might be needed. The exam might simply expect: "stainless is generally good, but watch out for chlorides causing pitting."

- *Materials for High Temp:* Common knowledge: **Carbon steel** loses strength and oxidizes at elevated temperatures (above ~500°C it scales quickly). **Stainless steels** and **chromium-molybdenum steels** are better up to maybe 600-700°C depending on grade. **Nickel-based superalloys** (Inconel, Hastelloy) are used for really high temperatures (e.g. turbine blades) because they form very stable oxides and maintain strength. **Ceramics** can withstand extremely high temperatures and don't really corrode (they're already "corroded" in a sense, being oxides or similar), but they have other issues (brittleness). If the exam gives a scenario like "exhaust gases at 1000°C," a safe guess is that a **ceramic liner or a nickel alloy** would be needed, not plain steel.

- *Plastics and composites:* Don't forget, corrosion isn't just a metal problem. Polymers can degrade too (though we usually use the term "degrade" not corrode). UV light, heat, or certain solvents can embrittle plastics. Fiber-reinforced composites can suffer environmental attack on the matrix. Again, probably beyond FE to ask specifically, but as an engineer you should ensure non-metallics are also compatible (e.g., do not use a plastic that absorbs water and weakens in a hot water service).

- *Galvanic environment detail:* The **presence of an electrolyte** (like seawater, acids, moist soil) not only enables galvanic corrosion but also affects uniform corrosion rates. For example, steel in dry rural air might form a little surface rust and then stop (no continuous water film). The same steel in a coastal humid environment rusts constantly. If a question compares corrosion rates in different environments, the more **conductive and oxygen-rich** environment typically causes more corrosion. Oxygen is a bit of a double-edged sword: you need it for the common cathodic reaction (oxygen reduction), so without oxygen certain corrosion (like rusting) slows. But some metals rely on oxygen to maintain a passive film (stainless needs oxygen to stay passive). In stagnant crevices, steel might not corrode much if oxygen is totally gone *and* there's no aggressive species building up; but usually stagnant water leads to a differential cell and makes it worse inside.

- *Electrochemical vs Chemical corrosion:* One could note that not all corrosion is purely electrochemical. Some high-temperature attacks (like carburization, nitridation, or certain chemical dissolutions) might be more direct chemical reactions without an obvious anode/cathode. But for the FE exam, you can assume corrosion of metals = electrochemical, and high-temp oxidation = analogous to corrosion but in gas phase.

Explanation & Analysis: To effectively tackle exam problems about environment and material compatibility, use a logical thought process:

Identify the Environment: What is the medium? Is it water (fresh, salt?), air (humid, dry, polluted?), acid, base, chemical solvent, high temperature gas, etc.? Is it static or flowing? Each of these triggers certain concerns:

Water + air (especially saltwater): expect electrochemical corrosion; think galvanic series, pitting if passive metals, etc.

Acidic environment: many metals will corrode fast (unless it's a specific acid that some metals resist, e.g. nitric acid actually induces stainless to passivate while hydrochloric acid eats it alive).

Basic (alkaline) environment: some metals like aluminum will corrode (its passive film dissolves in high pH), whereas steels often do okay in moderate alkali (except for risk of hydrogen embrittlement).

Solvents: mostly a concern for plastics (like some plastics crack in certain organics) and maybe for stress-corrosion in combination (like stress cracking of polycarbonates in certain chemicals).

High temperature air: oxidation/scaling of metals.

Presence of specific ions: chlorides (Cl^-) cause pitting/SCC in some alloys; sulfates might not be too corrosive by themselves but can form deposits; H_2S (sulfide) can cause hydrogen embrittlement in steels ("sulfide stress cracking").
Bacteria/microbes: not likely on exam, but microbial corrosion in soils can accelerate attack (just a note that environment includes biological factors sometimes).

Match Material to Environment: There's usually a known pairing:

For *seawater*: common materials include copper-nickel alloys, bronzes, certain stainless (with caution), titanium (excellent but

pricey), or coatings plus cathodic protection on steel. Aluminum does okay in seawater but will pit; it's often coated. Magnesium corrodes extremely fast in saltwater (not suitable for structural use in seawater, though it's used as sacrificial anodes).

For *acids*: no single answer; depends on acid. Sulfuric acid might use stainless or high-silicon cast iron or special alloys; hydrochloric acid often needs special nickel alloys or plastics; acetic acid is mild enough that stainless works. The exam probably won't go deep here, but if they mention "strong acid," assume normal steel fails quickly, stainless might fail if it's a reducing acid like HCl (so maybe a special alloy or nonmetal is needed).

For *caustic (NaOH)*: steel actually is fairly resistant to caustic at moderate concentrations (it forms iron carbonate or passivates somewhat), but at high concentrations and temperatures, nickel alloys or certain stainless (with nickel) are used. Also, caustic causes a form of SCC in carbon steel above certain strengths ("caustic embrittlement" historically in boilers).

For *high purity or oxygenated water*: stainless is often used to avoid contamination and for corrosion resistance; carbon steel in pure water can pit or rust because there's nothing to inhibit it. In boilers, they remove oxygen (add chemicals) to protect the steel.

For *high temperature air*: if above ~550°C, go with stainless or better. For really high (800°C+), use Inconel or ceramics. If they just broadly say "high temperature corrosion," think about alloys with chromium/aluminum.

For *sub-zero or cryogenic*: corrosion generally slows at lower temp (electrochemical reactions are slower), but a brittle fracture might be a bigger concern than corrosion in such a scenario (not directly corrosion but material property change).

Galvanic Compatibility Considerations: If multiple materials are present, ask: is the environment conductive enough to galvanically couple them? If yes, ensure the combination is okay. Some common practice: avoid coupling aluminum and copper in wet environments (aluminum will corrode); avoid copper and steel in aggressive environments (steel will corrode near the junction); if you must, isolate them. Also, sometimes coatings are applied to one of the pair to mitigate (like copper plumbing connected to steel, you use dielectric unions or ensure one is coated).

A possible exam question: "Two different metals are used in a design. What could be done to reduce galvanic corrosion between them?" Answer: electrically isolate them (non-conductive gasket, bushing) or ensure they aren't in an electrolyte (keep it dry or sealed) or apply cathodic protection, or select metals closer in galvanic series.

Examples to solidify:

Underground steel pipe in soil: Soil is an electrolyte (especially if damp). The environment is basically like a dilute saltwater with varying oxygen pockets. This screams **cathodic protection + coatings** as the solution, which is indeed standard. Material selection – you could use something like ductile iron with protective linings, but generally you protect carbon steel with coatings and CP because it's cheaper than making the whole pipe of stainless (and even stainless can pit in chloride-y soil).

Bolts on an outdoor structure: If they use a different material from the members, check compatibility. Often galvanic series: galvanized (zinc-coated) bolts on steel are fine (zinc protects steel). But stainless bolts on carbon steel could make the steel around the contact corrode (steel becomes anode). Usually small area of steel to large cathodic stainless bolt = not great. The exam might expect you to know to avoid such pairing in wet environments, or mitigate it.

Chemical tank selection: If a question asks what material a storage tank or heat exchanger tubing should be made of for a certain fluid, it's about compatibility. E.g., a tank for storing 50% NaOH (caustic soda): carbon steel is actually commonly used for many caustic storage at ambient (with some precautions) because it's fairly compatible and economical, whereas something like HCl storage often uses rubber-lined steel or FRP (fiber-reinforced plastic) tanks because HCl attacks steel quickly.

High-temp furnace part: e.g., a radiant tube in a furnace – material must resist scaling: so likely a stainless steel or Fe-Cr-Al alloy, not plain steel. If the question gave options of materials, the one marketed for high-temp (like "Inconel 600 alloy" or "310 stainless steel") would be correct, as opposed to "A36 structural steel" which is a no-go at red heat.

When environment changes over time: Sometimes materials that are fine initially can fail as environment evolves. For instance, if water sits and becomes stagnant, oxygen gets consumed and you can get weird corrosion like sulfate-reducing bacteria causing pitting. Or a system that cycles wet/dry can be worse (dry salt deposits absorb moisture and create concentrated brine on each rewetting). The exam likely won't go that deep, but a general awareness helps interpret descriptions. If they say "corrosion was observed after the system was shut down and left idle," it could hint at something like that (maybe not relevant though).

In summary, **match the material to the environment**. On the FE exam, you won't have a huge materials compatibility chart to look at (though the reference has some data, you probably won't need it). Use general knowledge: stainless for corrosion, special alloys for tough conditions, coatings/inhibitors to assist, and avoid known bad mixes like aluminum in strong base, or non-resistant metals in acid, or mixing far-apart metals in saltwater. If stuck, think about the anodic/cathodic tendencies and whether the environment will facilitate a corrosion cell, and pick the solution that cuts that off. Remember, the exam isn't trying to trip you up on memorizing obscure data; they want to see if you grasp the principles of corrosion control and can apply a bit of logic to material & method selection. With the above understanding, you'll be equipped to tackle those corrosion questions confidently.

Topic 10 - Failure Mechanisms

Topic Introduction: Failure mechanisms describe how and why materials break or degrade under various conditions. In the context of the **FE Mechanical Exam**, this topic matters because you'll face questions on predicting material life (e.g. **Will this part creep and fail after long use at high temperature?** or **How many cycles can this shaft survive before fatigue crack?**). The typical question archetypes include calculating deformation or time to failure at **high temperature (creep)**, determining **fatigue life from S–N curves**, summing **damage from variable loads (Miner's rule)**, assessing if a **crack will propagate (fracture mechanics)**, understanding the effect of **temperature on brittle vs. ductile behavior (DBTT)**, and identifying modes like **wear or thermal shock**. In exam terms, *Failure Mechanisms* problems are about recognizing the right mode of failure and applying the relevant principle or formula to avoid surprises on exam day.

K09.T10.S01 – Thermal Failure: Creep Deformation & High-Temperature Rupture

Principle (High-Temperature Creep): Creep is the gradual, time-dependent deformation that occurs when a material is held under a constant load at **elevated temperature**. Key points to build intuition include:

- **Gradual Strain:** Even under a steady stress below yield, a material can *slowly* stretch or deform over hours, weeks, or years if the temperature is high enough (usually significant creep occurs at $T > \sim 0.4$–0.5 of melting temperature in K). This is why turbine blades, furnace components, or jet-engine parts "creep" over time.
- **Steady-State Stage:** Creep typically has three stages – primary (decelerating creep rate), **secondary or steady-state** (constant creep rate), and tertiary (accelerating to rupture). The *steady-state creep rate* is crucial for long-term life predictions, as it often dominates the useful life before rapid failure.
- **Creep Rupture:** Eventually, after enough creep strain accrues (especially once tertiary creep kicks in), the material can **fracture** (creep rupture). The time to rupture decreases if stress or temperature increases. Engineers use creep rupture data (often plots of stress vs. rupture time at temperature) to ensure a component will last the intended life without breaking.
- **Exponential Sensitivity:** Creep is **highly sensitive to temperature**. A slight rise in temperature can exponentially increase the creep rate – meaning parts that are safe at 500°C might creep dangerously at 600°C under the same load. Always consider both stress *and* temperature in creep problems.

Exam Handbook Search Cues (Not affiliated with or endorsed by NCEES): creep, steady-state creep rate, strain rate, rupture

Footnotes:

- *Units:* In creep calculations, stress (σ) is typically in **MPa** (N/m²) and temperature **must be in Kelvin** for exponential laws. Time to rupture might be given in hours.

- *Material Note:* Creep is most pronounced in metals at high T (e.g. lead creep at room temp since its melting point is low; steels creep at red-hot temps). Ceramics can creep too when hot, but polymers creep even at room temperature (think of a plastic shelf sagging over months).

Equation Passport: Steady-State Creep Rate – predicts the **rate of deformation** under constant stress at high temperature (secondary creep). This Arrhenius-type equation helps estimate how quickly a material will creep (strain per second) given service conditions:

Creep Rate Law: $\dot{\varepsilon}_{ss} = A\,\sigma^n \exp!\left(-\frac{Q}{R\,T}\right)$

Variables and Units:

- $\dot{\varepsilon}_{ss}$ – steady-state creep **strain rate** (s^{-1}), i.e. how fast strain accumulates in secondary creep.
- A – material constant (frequency factor), **units vary** so that $A\,\sigma^n$ yields s^{-1} (often empirically fitted).
- σ – applied **stress** (Pa or MPa). Higher σ -> faster creep.
- n – **stress exponent** (dimensionless). Indicates how sensitive creep rate is to stress (e.g. $n \approx 1$ for diffusion creep, $n > 3$ for dislocation creep).
- Q – **activation energy** for creep (J/mol). Energy barrier for creep mechanism (e.g. lattice diffusion energy).
- R – gas constant (8.314 J/mol·K), ensures units in the exponential are dimensionless.
- T – **absolute temperature** (K). Use Kelvin in this formula.

Assumptions & Scope: Applicable in the **secondary creep** regime (constant creep rate), under **constant load** and **constant high temperature**. Assumes a single dominant creep mechanism over the temperature range (the constants A, n, Q are usually valid for a specific mechanism and T-range). Not valid once **tertiary creep** starts (when damage/failure accelerates). For design, we ensure service stress and T keep the component in secondary creep for its required life.

Limit Checks: If $\sigma \to 0$, then $\dot{\varepsilon}_{ss} \to 0$ (no stress, no creep – as expected). If $T \to 0$ K, $\exp(-Q/RT) \to 0$ so $\dot{\varepsilon} \to 0$ (near absolute zero, virtually no creep – materials won't creep when too cold). As T increases, note $\exp(-Q/RT)$ grows rapidly – e.g. raising T by 10% can more than double $\dot{\varepsilon}$ if Q/RT was around 1–2. This **temperature sensitivity** is a hallmark of creep.

Use vs. Sibling Equations: Use this steady-state creep formula instead of a simple elastic or plastic formula when dealing with **long-term deformation** at high T. Do *not* confuse creep strain with instantaneous elastic strain ($\varepsilon = \sigma/E$) – creep accumulates over time, even under constant load.

Common Exam Traps:

- **Unit mistakes:** forgetting to convert temperature to Kelvin. For example, using 300°C instead of 573 K in the exponential will give nonsense results. Always add 273 when needed.
- **Interpreting n:** n is not a stress *power* you integrate; it's an exponent. If $n = 5$, doubling σ -> 32× higher $\dot{\varepsilon}$. Don't treat it linearly.

- **Creep vs. Yield:** just because creep occurs doesn't mean stress exceeded yield. Creep can happen at stresses well below yield if temperature is high. Don't assume failure by creep implies an initial yield or ultimate failure criterion – it's a different mechanism.
- **Time units:** The formula gives strain *rate*. If asked how much strain accumulates in 10,000 hours, multiply $\dot{\varepsilon}$ by time (consistent units). A common mistake is to plug time into the formula – resist that; this formula already gives per second or per hour strain accumulation.

Variations and Typical Values: Creep behavior can vary by material and conditions:

- **Creep Phases:** Primary creep (decelerating) and tertiary creep (accelerating to rupture) are sometimes modeled with more complex formulas, but on the FE exam the focus is usually steady-state creep rate or total creep strain over long time (which is roughly rate × time in secondary stage). If needed, you might use average rate for a given period.

- **Material Differences:** Materials with higher melting points or strong interatomic bonds (e.g. Tungsten or ceramics) exhibit creep only at very high temperatures. Low melting alloys (solder, lead) creep at room temperature. Polymers creep significantly at room conditions (ever notice a sagging plastic?), but exam problems usually center on metals.

- **Temperature Influence:** A common **design rule** is to avoid operating above ~40% of melting temperature (in K) to **minimize creep** in metals. For instance, a steel that melts around 1500°C (1773 K) will start creeping noticeably above roughly 0.4×1773 ≈ 710 K (about 437°C). Below that, creep is negligible during typical service life.

- **Creep Rupture Data:** Often given as an empirical relation or graph (Larson-Miller parameters, etc.), but the FE exam may simply ask conceptual questions like *"what happens to creep life if temperature increases by 20°C?"* (Answer: it shortens dramatically because of the exponential term). Typical creep rupture times can range from a few hours at extreme stress/T to decades at moderate conditions.

Special Note – Calculator Use: The exponential term $\exp\left(-Q/(RT)\right)$ can be *tiny*. Use your calculator's **EXP** function for accuracy: e.g., on TI models exp(-Q/(R*T)). Also, watch out for big numbers – if $Q/(RT)$ is large (say 20 or 30), $\exp(-Q/RT)$ might underflow to zero on some calculators. In those cases, conceptually realize it means "virtually zero creep" rather than struggling to get a precise number.

Explanation & Analysis: In an exam problem, if you're asked *"How much will this rod elongate after 5,000 hours at 600°C under 50 MPa?"*, you'd reach for the creep rate law.

Explanation: The steady-state creep equation gives the *rate* at which strain accumulates. Multiply that rate by time to estimate total creep strain (assuming secondary creep dominates). It applies when a component is under constant load for long periods – like pipes in a power plant that gradually stretch.

Analysis of terms: Each part of $\dot{\varepsilon} = A\sigma^n e^{-Q/(RT)}$ has a physical meaning:

- A and n capture how the material responds to stress. A larger A or n means the material creeps easier under stress. For example, $n \approx 1$ might indicate diffusion-based creep (linear in stress), whereas $n \approx 5$ suggests dislocation climb (strong stress sensitivity).

- Q and T show the thermal activation aspect – Q is like a "hurdle" energy for atoms to slide or vacancies to move. Higher T helps overcome this, hence the negative exponential. If Q is high, the material is more resistant to creep until T is sufficiently high.

- **Physical units check:** Suppose $\sigma = 50$ MPa, $n = 4$, $T = 873$ K (600°C), $Q = 200$ kJ/mol, $A = 10^{-5}$ (units such that $A\sigma^n$ gives 1/s). Then $Q/(RT) \approx 200{,}000/(8.314873) \approx 27.5$. $\exp(-27.5)$ is 1.1×10^{-12}. Multiply by $A\sigma^n = 10^{-5} * (50 \times 10^6 \text{Pa})^4$ (which is huge) – the result might be, say, 3×10^{-10} s⁻¹. That means strain grows by 3×10^{-10} per second, or about 9.5×10^{-3} (0.95%) over 1 year. This sanity check shows creep strain would be under 1% per year – possibly acceptable. Since $\dot{\varepsilon} = A\sigma^n \exp(-Q/RT)$, the temperature effect comes from the Arrhenius term. Comparing two temperatures T_1 and T_2:

$$\frac{\dot{\varepsilon}(T_2)}{\dot{\varepsilon}(T_1)} = \exp\left[\frac{Q}{R}\left(\frac{1}{T_1} - \frac{1}{T_2}\right)\right]$$

For $T_1 = 873$ K(600°C) and $T_2 = 923$ K(650°C), this ratio is $\approx 4 - 5\times$, so a modest temperature increase can drastically shorten creep life.

- Common Mistake Alert: Students might forget that time needs to be converted consistently (if creep rate is per second, time must be in seconds; if per hour, time in hours). Also be cautious: sometimes exam problems give you a creep rupture stress for a given life (e.g. "at 600°C, a stress of 40 MPa leads to rupture in 10,000 hrs"). In such cases, use proportional reasoning or provided charts – the above formula may not be directly needed unless they specifically give you A, n, Q values.

In summary, creep is about **materials slowly deforming and eventually failing when kept hot under stress**. Master the steady-state creep equation and remember the exponential temperature effect – it's the key to answering any creep-related question on the FE exam confidently.

K09.T10.S02 – Fatigue Failure: S–N Curves, Endurance Limit & Influencing Factors

Principle (Fatigue under Cyclic Loading): Fatigue failure is the process in which **cracks form and progressively grow** when a material is exposed to **repeated or varying loads**. Even if each individual load cycle is well below the static strength of the material, the cumulative effect can cause failure after enough cycles. Key intuition bullets:

- **S–N Behavior:** Materials have an **S–N curve** (Stress vs. Number of cycles) obtained from lab tests. It shows how the allowable stress amplitude *S* decreases as the number of cycles *N* to failure increases. At high stresses, failure happens in few cycles (left side of curve); at lower stresses, the part can survive many more cycles (moving right).
- **Endurance Limit:** Many **ferrous metals (iron/steel alloys)** and some others exhibit a **fatigue endurance limit**: a stress amplitude below which fatigue failure *does not occur* for essentially infinite life. On an S–N plot, this appears as the curve flattening out into a horizontal line at some stress level S_e. For example, a typical steel might have $S_e \approx 0.4$–$0.5\, S_{\text{UTS}}$ (40–50% of its tensile strength) as a limit. If you keep stress below that, the steel won't

fail even after 10^6 or 10^7 cycles. **Non-ferrous metals** (aluminum, copper, etc.) usually **do not have a true endurance limit** – their S–N curve keeps dropping gradually, so given enough cycles *any* stress can cause fatigue (no horizontal plateau).

- **Factors Affecting Fatigue Life:** Real parts often have lower fatigue strength than lab test specimens. **Surface finish** plays a big role – a rough surface or scratches act as stress risers and reduce fatigue life (polished = longer life). **Size** matters: larger components have a higher chance of containing a critical flaw; they tend to have lower endurance limit than small test bars (hence a size factor in design). **Stress concentrations** (notches, holes, fillets) dramatically reduce fatigue strength – a sharp notch can initiate a crack much sooner. Design techniques like adding fillets, removing sharp corners, polishing, shot-peening (introducing compressive surface stress) all aim to improve fatigue performance.
- **Load Characteristics:** Fatigue depends on the *range* and *mean* of stress. Fully reversed loading (alternating tension-compression, mean = 0) is the most damaging for a given amplitude. If mean stress is tensile (e.g., fluctuating between a positive max and min above 0), failure can occur at lower amplitudes (the **Goodman** or **Soderberg** criteria adjust for mean stress in design). The FE exam might not delve deep into Goodman diagrams unless a question provides one, but remember: a higher mean stress (static bias) makes fatigue worse.
- **Microscopic Crack Growth:** Fatigue failure usually starts with a tiny crack at a stress concentration which grows incrementally each cycle. Early on, the damage is internal – no obvious signs. Eventually the crack grows large enough to significantly reduce cross-section, then final fracture happens suddenly. On a broken part, you might see beach marks or striations indicating the progressive crack advance from fatigue, plus a final brittle fracture area when it let go.

Exam Handbook Search Cues (Not affiliated with or endorsed by NCEES): fatigue, S-N curve, endurance limit, stress ratio R

Footnotes:

- *Stress Ratio R:* Defined as $R = \sigma_{\min}/\sigma_{\max}$ for one load cycle. Common values: $R = -1$ means a fully reversed cycle ($\sigma_{\min} = -\sigma_{\max}$, like going from +100 MPa to -100 MPa), $R = 0$ means zero to tension (like a pulsing load from 0 to +X), $R = 0.1$ might be 10 MPa min to 100 MPa max. **Be careful:** R is not the same as factor of safety or anything – it strictly relates min and max stress in the cycle.

- *Units:* Stress amplitudes are usually given in **MPa** (or psi in USCS). Number of cycles N is a pure number (often plotted on log10 scale). Fatigue life might be given or asked in terms of **number of cycles** or **time** (if frequency of cycling is given, you can convert cycles to hours).

- *Terminology:* "High-cycle fatigue" typically means $N > 10^4$ or 10^5 cycles (primarily elastic strain each cycle), whereas "low-cycle fatigue" (N in the hundreds or low thousands) involves significant plastic strain each cycle. The FE exam is more likely to stick with high-cycle concepts unless explicitly stating low-cycle (which would involve strain-life or Coffin–Manson equations not usually needed).

Diagram Passport: S–N Fatigue Life Curve – helps determine how many cycles a material can survive at a given stress amplitude, or vice versa. This is a primary tool for fatigue questions:

Diagram Title & Role: S–N Curve (Wöhler curve) – relates **Stress amplitude (S)** to **Number of cycles to failure (N)**. It answers questions like "Given a cyclic stress of X, will the part last Y cycles?" by finding where that stress intersects the curve.

Axes and Quantities: Horizontal axis is **Number of cycles,** N (usually logarithmic scale, e.g. 10^1 to 10^6 or 10^7). Vertical axis is **Stress amplitude,** S (often given as alternating stress or sometimes max stress for fully reversed, in MPa or psi). For fully reversed loading, stress amplitude = half the range = = $|\sigma_{\max}|$ (since $\sigma_{\min} = -\sigma_{\max}$ in that case).

Key Regions & Thresholds: On the left end (low N) is the **low-cycle fatigue** region – steep drop in S as N increases, often involving plastic deformation per cycle. Beyond a certain N (like 10^5 or 10^6), the curve flattens for steels: that flat stress = **Endurance Limit (S_e)**. Above this stress, no matter how many cycles, failure will occur; at or below it, the material could endure 10^8 or more cycles without failing (in practice defined as "infinite life"). For materials without a clear knee, the "fatigue strength" is sometimes given for a specific life (e.g. stress at 10^8 cycles).

How to Read (Exam-style): If a question gives you an S–N graph or data:

- Identify the given stress amplitude on the Y-axis, trace horizontally to intersect the curve, then drop down to the X-axis to read the **predicted life (N)**. For instance, if 200 MPa corresponds to ~500,000 cycles, that's the expected life at 200 MPa.
- Conversely, given a required life, go to that N on X-axis, go up to the curve, then read left to find the max allowable stress. E.g., if a component needs 10^6 cycles, find $N = 10^6$ on the graph and see the corresponding S (that should be at or near the endurance limit for steel).
- If the given stress is below the endurance limit (for ferrous metal), you can directly say it "should not fail by fatigue" because it's in the infinite life region. This is a quick check on the exam: compare stress amplitude vs. published S_e.

Common Misreads & Pitfalls:

- Watch the **log scale** on N: equal spacing might mean 10^3, 10^4, 10^5… not linear. Don't interpolate N linearly – use ratios or log paper approach.
- Distinguish **stress amplitude vs. mean stress vs. stress range**. The S–N curve is usually based on stress amplitude for fully reversed loading (mean = 0). If a problem involves a nonzero mean, an equivalent fully reversed stress might need to be calculated or a Goodman chart used – but unless provided, the exam likely expects you to use modifying factors qualitatively.
- If multiple curves are shown (sometimes one for different surfaces or treatments), be sure to pick the correct one. For example, a shot-peened part might have a higher curve than an untreated part.
- Do not confuse the **endurance limit** with yield or ultimate strength. Endurance limit is typically much

lower. For instance, a steel with $S_{\text{UTS}} = 600$ MPa might have $S_e \approx 300$ MPa. Many students mistakenly think "infinite life if stress < yield" – wrong! It must be below the *fatigue endurance* strength, which is usually well below yield for steels.

- Realize that an **"infinite life" design** often targets a certain cycle count like 10^6 or 2×10^6 as effectively infinite for engineering purposes. Don't misinterpret a finite number like 10^6 as truly infinite – it's just a convention to stop testing there if no failure.

Variations & Related Concepts:

- **Basquin's Equation:** High-cycle fatigue data are often fit by a power law: $\sigma = AN^B$, where $B < 0$. (This is equivalent to writing $\sigma = CN^{-b}$with $b = -B$.). Here C and b are material constants. For example, doubling the allowed cycles might require dropping stress by a factor of $2^{-1/b}$. You generally won't need to derive this, but it explains the log–log linear region on an S–N plot.

- **Low-Cycle Fatigue:** If a problem hints at low cycle (N maybe < 1000), plastic strain comes in and **Coffin–Manson** relationship $\Delta\varepsilon^p/2 = \varepsilon_f'^{(2N)^c}$ would apply. The FE exam rarely delves into that unless specifically stated, since it's more complex. Just note: low-cycle fatigue uses strain-based approaches and no endurance "limit" – the concept of infinite life doesn't apply when each cycle does lasting damage.

- **Fatigue Strength vs. Endurance:** For materials without a true endurance limit (like aluminum), you might be given a fatigue strength for a certain life (e.g. "fatigue strength = 100 MPa at 5×10^8 cycles"). That's the stress for that life. If asked "will 80 MPa cause failure by 5×10^8 cycles?", since 80 < 100, it should survive at least that many cycles (with some margin).

- **Stress Concentration and Notch Sensitivity:** There are fatigue stress concentration factors (K_f) that are lower than theoretical K_t due to notch insensitivity at high cycle, but unless the exam gives K_f, assume worst-case that a notch's full stress concentration applies. Qualitatively: a smaller notch radius (sharper) or harder material (less notch ductility) means $K_f \approx K_t$ (fully effective), whereas a ductile material can yield a bit at the notch tip, reducing the effective stress range.

- **Surface treatments:** Be aware of methods like **surface hardening or residual compressive stress (shot peening, carburizing)** – these improve fatigue life by delaying crack initiation. Conversely, surface tensile stresses (e.g. from welding without stress relief) or corrosive environment (corrosion fatigue) worsen fatigue life. If the exam asks conceptually which condition yields longest fatigue life, pick the one with smoother surface, compressive surface stress, smaller size, lower mean stress, etc.

Explanation & Analysis: When solving a fatigue problem on the FE exam, first classify: *Is it asking for the number of cycles to failure, factor of safety in fatigue, or just conceptually which design is better for fatigue?* **Explanation:** Use the S–N data: if an S–N curve or table is provided, find the point corresponding to the stress or cycles in question. For example, *"A steel rod sees a cyclic stress of 200 MPa. According to the S–N curve, it lasts 2×10

DON'T MOVE ON YET!

Work Through Some Solid Practice Problems
while the Material of this Knowledge Is Still Fresh
THIS IS HOW THE CONCEPTS LOCK IN.

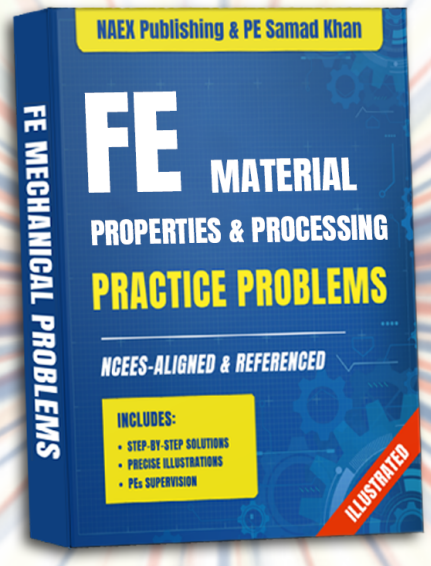

CLICK HERE TO PRACTICE

You'll be taken to our Discord Server, where the problems are located.

KNOWLEDGE 10

FLUID MECHANICS

- NAEX Publishing -

"This publication is not affiliated with or endorsed by NCEES".

Topic 01 - Fluid Properties

Topic Introduction: Fluid properties are the fundamental characteristics of fluids that you'll use throughout many FE Mechanical problems. Understanding properties like density, viscosity, and surface tension is crucial because they appear in equations for fluid statics (pressures in liquids), fluid dynamics (Reynolds number, drag forces), and thermodynamics (property tables). On exam day, you'll often be asked to **convert between these properties** (e.g. from specific gravity to density), **plug them into formulas** (like using viscosity in a Reynolds number or shear stress calculation), or **extract them from the provided tables**. The typical question archetypes include finding a fluid's density given specific gravity, computing a shear stress with a given viscosity and velocity gradient, determining pressure at a point under a fluid column, or estimating capillary rise in a tube. In all cases, knowing the definitions, units, and inter-relations of fluid properties will make the solutions straightforward.

K10.T01.S01 – Density, Specific Weight, Specific Volume, Specific Gravity

Principle (Definitions & Units):

- **Density (ρ)** – mass per unit volume of a substance. It tells how much mass is packed into a given volume. SI units: kg/m³. Higher density means heavier for the same volume.
- **Specific Weight (γ)** – weight per unit volume. It equals density times gravitational acceleration (γ = ρ·g). Units: N/m³ (since weight is a force). Essentially, it's the weight of 1 m³ of the fluid.
- **Specific Volume (ν)** – volume per unit mass, i.e. the inverse of density (ν = 1/ρ). Units: m³/kg. Useful for expressing how much space a certain mass of fluid occupies (common in thermodynamics).
- **Specific Gravity (SG)** – ratio of a fluid's density to a reference density (usually water at 4 °C for liquids). It's dimensionless. SG tells you how heavy a fluid is relative to water (SG > 1 means heavier than water, SG < 1 lighter than water).

Just remember: mass and weight are not the same (mass is intrinsic, weight = mass × g). In SI units this distinction is automatic (kg vs N), but in US units you must be careful [^1].

Exam Handbook Search Cues (Not affiliated with or endorsed by NCEES): density; specific weight; specific gravity; mass per volume

Footnotes:

[^1]: **Mass vs Weight (Units):** In US Customary units, mass is in slugs or lbm, and weight (force) is in lbf. A conversion factor $g_c = 32.174\ \frac{\text{lbm}\cdot\text{ft}}{\text{lbf}\cdot\text{s}^2}$ is used in formulas like $F = m\,a/g_c$ or $\gamma = \rho\, g/g_c$ to keep units consistent. For example, water's density is ~1.94 slug/ft³ (which corresponds to 62.4 lbm/ft³) and its specific weight is 62.4 lbf/ft³ at standard gravity.

Variations & Typical Values:

- **Relation to Weight:** $\gamma = \rho\, g$. This connects mass density to weight density. For example, water has $\rho \approx 1000\ \text{kg/m}^3$, so $\gamma = 1000 \times 9.81 \approx 9810\ \text{N/m}^3$. In US units, the same water has $\gamma \approx 62.4\ \text{lbf/ft}^3 (awell-knownvalue) and \rho \approx 62.4\ \text{lbm/ft}^3$ (numerically the same in water's case because g_c cancels with g).
- **Specific Volume:** $\nu = \frac{1}{\rho}$. For instance, if $\rho = 1000\ \text{kg/m}^3$, then $\nu = 0.001\ \text{m}^3/\text{kg}$. Gases have much larger specific volumes (e.g. air $\nu \approx 0.83\ \text{m}^3/\text{kg}$ at STP) because their density is low.
- **Specific Gravity:** $SG = \frac{\rho}{\rho_{\text{water}}}$. Water's SG is defined as 1.0 (at 4 °C). Mercury, with $\rho \approx 13{,}550\ \text{kg/m}^3$, has $SG \approx 13.6$. A fluid's SG is the same number in any unit system since it's a ratio. On the FE, you might be given SG and need to find density: just multiply SG by $1000\ \text{kg/m}^3$ (for liquids, using water as reference) or by $62.4\ \text{lbm/ft}^3$ in US units.
- **Incompressible vs Compressible:** For liquids (e.g. water, oil), ρ is fairly constant with pressure and temperature (incompressible assumption). For gases, ρ changes significantly with pressure/temperature (you'd use ideal gas law, covered elsewhere). On the exam, assume liquids are incompressible unless told otherwise.

Special Notes: No calculator tricks needed here – just remember to use consistent units. If a problem gives specific gravity, it's a hint to multiply by water's density to get ρ. Also, be mindful that weight = mass × g; don't plug a weight value into a formula expecting mass. Always check units on your input values.

Equation Passport: Density – relates mass to volume for a uniform substance.

Formal Definition: $\rho = \frac{m}{V}$.

Variables:

- m – mass of the fluid portion (kg).
- V – volume occupied by that mass (m³).
- ρ – density (kg/m³).

Assumptions & Scope: Applies to any matter considered a continuum. It's the average density if the fluid is uniform. In practice, we often treat density as constant for liquids (valid if temperature changes are small). Make sure to distinguish mass vs weight: use ρ for mass calculations, and add g if you need weight (force).

Limit Checks: If you increase V while keeping m fixed (imagine expanding a gas), ρ decreases (approaching 0 as volume → ∞, which would be a vacuum). If you increase m in a fixed V, ρ increases (more mass stuffed into the same space). Extreme example: at a point in outer space ($m = 0$ in a volume), $\rho = 0$ (vacuum); in a neutron star, huge m in tiny V gives astronomical density.

Use vs. Related Equations: Use $\rho = m/V$ whenever you need to convert between an amount of substance and the volume it occupies. Use this instead of specific weight when you're dealing with mass (not force). To get weight from density, switch to $\gamma = \rho g$. For gases, if conditions change, you might use the Ideal Gas Law (in thermo) to find ρ instead.

Common Exam Pitfalls:

- Plugging weight (force) into $\rho = m/V$. Remember, m must be in kg (or slug) *not* in newtons or lbf. If a problem gives you a force, convert it to mass by dividing by g.
- Mixing units for volume and mass (e.g. using kg with ft^3 by mistake). Always convert to consistent units (e.g. kg with m^3, or slug with ft^3).
- Confusing specific gravity with density. If you're given SG, don't treat that number as ρ directly. Adjust by the reference: $\rho = SG \times 1000$ kg/m^3 in SI. Likewise, a fluid with $SG = 0.8$ has density $0.8 \times 1000 = 800$ kg/m^3, not 0.8 kg/m³.
- Forgetting that density can vary with temperature (especially for gases and when using property tables). If precision matters, use the value at the given temperature (from tables or data provided, as in exam reference).

K10.T01.S02 – Viscosity (Dynamic & Kinematic) and Fluid Shear Stress

Principle (Viscosity & Shear): Viscosity is what makes fluids resist deformation – essentially fluid friction at the molecular level. There are two forms:

- **Dynamic (absolute) Viscosity (μ):** Measures the fluid's internal resistance to flow under an applied shear stress. Units: Pa·s (Pascal-second), which is N·s/m^2, or in traditional units, kg/(m·s). For water at room temperature, μ is about 1.0×10^{-3} Pa·s; for air it's much lower (~1.8×10^{-5} Pa·s). A higher μ means a "thicker" fluid (e.g. honey has a large μ, water is moderate, air is very low μ).

- **Kinematic Viscosity (ν):** Defined as ν = μ/ρ. Units: m²/s. It represents the fluid's viscous resistance relative to its density. It's useful in many fluid flow calculations (like Reynolds number). Think of ν as "how fast momentum diffuses" in the fluid. Water at 20 °C has ν ~ 1.0×10^{-6} m²/s, whereas air has ν ~ 1.5×10^{-5} m²/s (even though air's dynamic viscosity is lower, its density is so low that on a per-density basis, its kinematic viscosity is higher than water's).

- **Shear Stress in a Fluid (τ):** In a Newtonian fluid, shear stress is proportional to the rate of shear (velocity gradient). The classic formulation is **τ = μ (dv/dy)** – meaning the tangential stress (τ) on a fluid layer is the viscosity times the rate of change of velocity with respect to distance perpendicular to the flow. This is Newton's law of viscosity. Essentially, if one layer of fluid is sliding past another, viscosity μ tells us how much force per area is needed to sustain that relative motion. The larger the velocity gradient (dv/dy), or the higher the viscosity, the larger the shear stress.

Exam Handbook Search Cues (Not affiliated with or endorsed by NCEES): viscosity; dynamic viscosity (μ); kinematic viscosity (ν); shear stress; Newtonian fluid

Footnotes:

[^2]: **Viscosity Units and Conversions:** 1 Pa·s = 1 N·s/m^2 = 1 kg/(m·s). Another common unit is the **poise (P)** and **centipoise (cP)**. 1 cP = 0.001 Pa·s. Water's viscosity is about 1 cP at 20 °C. Be careful: if a viscosity is given in cP on the exam, convert it to Pa·s for use in SI equations. Similarly, kinematic viscosity might be given in cm^2/s or **Stokes** (1 St = 10^{-4} m²/s). Always convert to m²/s in calculations.

[^3]: **Newtonian vs Non-Newtonian:** The equation $\tau = \mu\, dv/dy$ assumes a Newtonian fluid – one with a constant viscosity independent of shear rate. Most common fluids (water, air, oils at moderate conditions) are Newtonian. Some fluids (like ketchup, blood, or thick slurries) are non-Newtonian – their apparent viscosity changes with shear rate. For example, a **power-law fluid** uses $\tau = K(dv/dy)^n$. However, FE exam problems almost always assume Newtonian behavior unless explicitly stated otherwise.

Variations & Related Concepts:

- **Kinematic Viscosity:** $\nu = \frac{\mu}{\rho}$. This is often encountered in dimensionless parameters like the Reynolds number $Re = \frac{\rho v L}{\mu} = \frac{vL}{\nu}$. In the exam reference handbook, ν might appear in units of m²/s or ft²/s. For example, water at 20 °C: $\mu \approx 1.0 \times 10^{-3}$ Pa·s and $\rho \approx 998$ kg/m^3, so $\nu \approx 1.0 \times 10^{-6}$ m²/s. Air at 20 °C: $\mu \approx 1.8 \times 10^{-5}$ Pa·s, $\rho \approx 1.2$ kg/m^3, so $\nu \approx 1.5 \times 10^{-5}$ m²/s. **Notice:** air's dynamic viscosity is ~50 times lower than water's, but its kinematic viscosity is ~15 times higher because air is so low-density.
- **Temperature Dependence:** For liquids, viscosity *decreases* with higher temperature (hot oil is runnier than cold oil). For gases, viscosity *increases* with temperature (gas molecules collide more as T rises). Keep this in mind: a problem at 50 °C might have a slightly different μ than at 20 °C. The exam may provide the necessary values or indicate to assume room temperature if not critical.
- **Laminar vs Turbulent Flow:** Viscosity is what dampens out fluid motion and allows laminar (smooth) flow. When inertial forces far exceed viscous forces (high Reynolds number), flow becomes turbulent. While solving FE problems, if you have a very low μ or ν, expect that it's easier for the flow to go turbulent. Conversely, a very viscous fluid will likely stay laminar at lower speeds. (The cutoff $Re \approx 2300$ for pipes is a key concept, but that belongs to fluid flow topics.)

Special Notes: When calculating shear stress using $\tau = \mu\, dv/dy$, ensure your units are consistent. For example, if dv/dy is given in s^{-1} (say, a velocity change of 5 m/s over 1 m, so 5 s⁻¹) and μ is in Pa·s, the resulting τ will be in Pa (which is N/m²). If using US units, you might need to include g_c if μ is given in lbm/(ft·s) to get τ in lbf/ft². Also, a quick sanity check: if μ → 0 (imagine a superfluid or very thin gas), then $\tau \to 0$ for any finite velocity gradient – no viscous drag. If $dv/dy \to 0$ (layers move together at same speed), $\tau = 0$ – no shear stress because there's no relative motion.

Equation Passport: Newton's Law of Viscosity – links shear stress to the velocity gradient in a Newtonian fluid.

Name & Purpose: Newton's Law of Viscosity – calculates the shear stress in a fluid given the rate of shear strain (velocity gradient). It essentially tells how "thick" or "sticky" a fluid is in terms of resisting flow.

Equation (1D shear): $\tau = \mu \frac{dv}{dy}$.

Variables:

- τ – shear stress (Pa, i.e. N/m²). This is the force per unit area parallel to the flow, exerted by the fluid as it shears.
- μ – dynamic viscosity of the fluid (Pa·s). Sometimes called coefficient of viscosity. (In the handbook, units might also be given in lbm/(ft·s), but use g_c in that case – see footnote [^2].)
- $\frac{dv}{dy}$ – velocity gradient perpendicular to the flow (s^{-1}). It represents how rapidly the fluid velocity changes with distance from the boundary. For a linear profile, $dv/dy = \frac{\Delta v}{\Delta y}$. In our diagram, $dv/dy = V/\delta$ (plate speed over fluid thickness).
- **Assumptions & Scope:** This formula assumes a Newtonian fluid (linear relationship between τ and dv/dy). It applies to laminar shear flows. The flow should be steady (so that the velocity gradient is not changing with time) and essentially one-dimensional (velocity varies mostly in one direction, e.g. with y as in a flat plate scenario). Most fluids in FE problems (water, air, oil) can be treated as Newtonian unless stated otherwise. If the flow is turbulent, μ still appears in calculations (like in the Moody chart for pipe friction, indirectly), but the simple linear law is effectively superseded by turbulent mixing – however, you won't use $\tau = \mu\, dv/dy$ directly in a turbulent flow question.

Limit Tests:

- If $dv/dy = 0$ (fluid moving as a solid block with no shear), then $\tau = 0$. This makes sense: no velocity difference, no friction between layers.
- If $\mu = 0$ (hypothetical inviscid fluid), then $\tau = 0$ regardless of velocity gradient – an ideal fluid offers no resistance to shear (slippery with no friction). Real fluids always have μ > 0, albeit small for gases.
- If the plates in our example move faster (larger V or smaller gap δ, so bigger dv/dy), the shear stress increases proportionally.

Use vs. Alternative Equations: Use this equation whenever you need to find shear stress or drag force in a laminar, viscous flow situation (e.g., Couette flow between plates, flow in a narrow gap, or the local wall shear stress in a laminar pipe flow at the wall – though for pipes you often use a Darcy–Weisbach approach instead). **Do not confuse this with solid shear formulas** – $\tau = G\,\gamma$ (materials) is different. Also, don't use this formula for turbulent flows or non-Newtonian fluids (there you'd use effective viscosities or given non-Newtonian models).

Common Exam Traps:

- Mixing up dynamic and kinematic viscosity. Remember, μ has units of Pa·s, whereas ν (nu) has units of m²/s. A typical mistake is to plug a kinematic viscosity value directly into $\tau = \mu\, dv/dy$. For example, a student sees ν for air (~1.5×10^{-5}) and uses that as μ in SI units, underestimating τ by a factor of density. Always check: if the number seems very small (~1* 10^{-5} range) it might be kinematic viscosity. Multiply by density to get μ.
- Unit errors when using $\tau = \mu\, dv/dy$ in US units. If μ is given in $\frac{\text{lbm}}{\text{ft·s}}$, and you use velocity in ft/s and y in ft, then $\mu\,(dv/dy)$ gives units of $\frac{\text{lbm}}{\text{ft·s}} \cdot \frac{\text{ft/s}}{\text{ft}} = \frac{\text{lbm}}{\text{ft·s}^2}$. To convert that to lbf/ft², divide by $g_c = 32.174$. In short, include a $1/g_c$ factor: $\tau\left(\text{lbf/ft}^2\right) = \frac{\mu\,(\text{lbm/(ft·s)})}{g_c}\frac{dv}{dy}$.
- Forgetting that viscosity is highly temperature-dependent. If a problem states "engine oil at 80 °C" and gives no μ, you might need to use a reference table. Using μ at 20 °C would be a significant error. Fortunately, exam problems usually provide the needed values or aren't extremely sensitive to this unless it's the point of the question.
- Using the formula outside its valid range: e.g., trying to apply $\tau = \mu\, dv/dy$ at a fluid-fluid interface in a multi-layer flow without careful sign convention (each fluid has its own μ and the shear stress is continuous across the interface). In general, stick to scenarios with one fluid and a solid boundary unless you know what you're doing.

K10.T01.S03 – Pressure as a Fluid Stress (Pressure at a Point)

Principle (Pressure in Fluids): Pressure (P) in a fluid is a normal stress that acts *equally in all directions* at a point (for a static or uniformly moving fluid). It is defined as **force per unit area** acting perpendicular (normal) to a surface. Key points: - Pressure is a **scalar**, not a vector – even though it originates from forces on a surface, at a given point in a static fluid the pressure value is the same in every direction. - In fluids at rest, pressure at a point has no direction; it pushes equally on all sides. (If you imagine a tiny fluid element shaped like a cube, pressure is like an invisible hand pressing on each face of the cube with equal intensity.)

- **Units:** Pascal (Pa) in SI, where 1 Pa = 1 N/m^2. Common multiples: kPa (10^3 Pa), MPa (10^6Pa). In US units, pressure is often given in psi (pounds-force per square inch) or psf (per square foot). For reference, standard atmospheric pressure is about 101.3 kPa = 14.7 psi = 2116 psf.

We usually distinguish between **absolute pressure**, measured relative to a perfect vacuum, and **gauge pressure**, measured relative to the surrounding atmospheric pressure. Gauge pressure is what most pressure gauges read (0 gauge at atmosphere). So: $P_{\text{abs}} = P_{\text{atm}} + P_{\text{gage}}$. Many real instruments read gauge pressure, but FE problems typically specify. If not specified, interpret based on context (e.g., gas-law problems require absolute).

Exam Handbook Search Cues (Not affiliated with or endorsed by NCEES): pressure; stress; pressure at a point; Pascal; psi; gauge pressure; absolute pressure

Footnotes:

[^4]: **Pressure vs. Force:** Students sometimes confuse pressure with force. Remember, pressure = force/area. A large force over a large area can result in a moderate pressure. Conversely, a relatively small force concentrated on a tiny area can create a huge pressure (think of a sharp needle – very small area, so even a small push yields high pressure that can puncture skin). Always identify the area over which a force acts if you need pressure, or the pressure and area if you need force ($F = P \times A$).

[^5]: **Gauge and Absolute:** Most pressures in fluid mechanics problems are given as gauge by default (especially if it says something like "the pressure in the tire is 35 psi" – that's 35 psi above atmosphere). If the problem wants absolute, it will either specify it or give atmospheric pressure to add. Vacuum pressure is just negative gauge pressure (e.g. -20 kPa gauge means 20 kPa below atmospheric). On the FE, if you see a pressure used in a

formula like $P = \rho g h$, that P is gauge (pressure difference from the surface). Use absolute pressures when applying the Ideal Gas Law or other thermodynamic relations.

Variations & Context:

- **Hydrostatic Pressure Variation:** Although pressure itself is just a point property, you should know that in a static fluid, pressure increases with depth according to $P = P_{\text{surface}} + \rho g h$. That formula comes from integrating $dP/dz = -\rho g$. For example, going 10 m deep in water (~ρ 1000 kg/m³) increases pressure by about $10009.8110 \approx 98{,}100$ Pa $= 98.1$ kPa. That's almost another atmosphere (which is why divers feel about 2 atm at 10 m depth).
- **Units cross-check:** 1 Pa is a very small pressure (about the pressure exerted by a dollar bill lying on a table). So we often deal in kPa or MPa. 1 MPa is about 145 psi. Conversely, 1 psi = 6894.7 Pa. You should be comfortable converting: e.g., 1 atm = 101.3 kPa = 0.1013 MPa = 14.7 psi = 2116 psf.
- **Other pressure measures:** Sometimes pressure is given as "head" of a fluid, especially in civil engineering context (e.g. head in meters of water). 1 m of water column is about 9.81 kPa. 1 inch of mercury (inHg) is another measure (used in barometers), where 1 atm ≈ 29.92 inHg. These might appear in fluid statics or vacuum problems, but unit conversion will be provided if needed.

Special Notes: On your FE exam approved calculator, computing pressure is straightforward – just be careful with scientific notation if dealing with Pa (since 101300 Pa might be entered as 1.013 x 10^5). When dealing with gauge vs absolute, it's more about conceptual understanding: if you're asked for an absolute pressure, make sure you add atmospheric pressure appropriately. Also remember, **pressure has no inherent direction** – you don't specify a pressure "vector". If a question asks "what is the magnitude and direction of pressure at this point?", the best answer is magnitude = X (in Pa) and **direction: it acts in all directions** or "on any surface through that point, normal to the surface."

Equation Passport: Pressure Definition – fundamental definition of pressure as force distributed over area.

Definition: $P = \frac{F}{A}$. (Pressure is force divided by the area over which that force is applied.)

Variables:

- P – pressure (Pa or other units of force/area). It represents the intensity of the normal force.
- F – normal force acting perpendicular to a surface (N in SI, lbf in US).
- A – area of the surface on which the force acts (m² in SI, ft² or in² in US).

Assumptions & Scope: This formula assumes the force is uniformly distributed over area A (or you're considering an infinitesimal area so that P is effectively constant on it). It defines a point property: strictly speaking $P = \lim_{\Delta A \to 0} \Delta F / \Delta A$. It applies to static or equilibrium situations directly. In a moving fluid, P still denotes the isotropic part of the stress state (with viscosity accounting for shear stresses separately). We assume the force is **normal** to the area – pressure doesn't include tangential (shear) forces.

Limit Checks:

- If $F = 0$ on some area (no force), then $P = 0$ – e.g. in a vacuum, pressure is zero because there's no force pressing on a surface.
- If A is made very large for a given force, P approaches 0 – the force gets "diluted" over a big area (think of lying on a bed of nails with a thousand nails – large combined area, so pressure on each point is smaller, maybe not puncturing the skin).
- If A is extremely small (pinpoint) for a given force, P can become extremely high (why a sharp needle can puncture skin easily – tiny $A \to$ huge P for the same push).

Use vs. Related Equations: Use $P = F/A$ to **compute force from a known pressure** (rearranged $F = PA$) when pressure acts on a flat surface (like finding the force on a dam gate given water pressure, using average pressure times area). Also use it to find pressure if you know a force distribution. However, if pressure varies over an area, you would integrate ($F = \int P \, dA$). And for pressure due to a fluid's weight at depth, use the hydrostatic formula $P = \rho g h$ (that formula is derived from $P = F/A$ combined with weight of fluid above, but it's more direct). Don't confuse pressure with stress in solids (though dimensionally the same); in fluids at rest, "pressure" *is* the normal stress.

Common Exam Pitfalls:

- Confusing pressure at a point with pressure force on a surface. If asked for "the force on a wall" due to fluid, don't just multiply the pressure at one depth by the full wall area (pressure varies with depth). You need the average or an integral. Conversely, if asked for pressure at a certain depth, don't compute total force.
- Using the wrong area. For example, in a hydraulic cylinder, if you're asked for pressure given a force, use the piston **cross-sectional area**. Using the lateral surface area would be incorrect.
- Forgetting to add atmospheric pressure for absolute queries. If a question gives you a gauge pressure and asks for an absolute pressure in Pascals, add 101325 Pa (assuming sea level ambient) *then* convert if needed.
- Incorrect unit conversions: A classic mistake is using diameter in formulas that need area. Remember $A = \pi d^2/4$ for circular areas. If you plug diameter directly for area you'll be off (seen in contexts like pressure = force/(πd²/4)). Another is mixing psi and Pa in the same equation without converting (1 psi is 6894.7 Pa, which is a huge difference).
- Assuming direction where not needed: sometimes a problem may simply ask "what is the pressure at this point in the fluid?" – Answer with a scalar value and units (e.g. 50 kPa), not "50 kPa downward." Pressure isn't a vector – the **force** on a specific surface has a direction, but pressure at a point is omnidirectional (for static fluids).

K10.T01.S04 – Surface Tension and Capillarity

Principle (Surface Phenomena): At a liquid-gas interface, the liquid molecules experience an imbalance of forces (they attract each other more than the gas molecules attract them). This creates a **surface tension (σ)** – effectively a force per unit length (N/m) along the surface, tending to minimize the surface area. Surface tension is why small droplets form spheres and why a steel needle can float on water if carefully placed (water's surface acts like a stretched membrane).

Surface Tension (σ): It's measured in N/m (newtons per meter) in SI. You can visualize σ as the force along a line of unit length on the liquid surface. For example, water at 20 °C has σ ≈ 0.073 N/m. Mercury has a much higher σ (~0.485 N/m) which is why it forms big beads.

Capillarity (Capillary Action): When a thin tube is inserted into a liquid, surface tension combined with adhesive forces between the liquid and tube can cause the liquid to rise or depress in the tube. **Capillary rise** happens when the liquid wets the tube (e.g. water in glass) – the liquid climbs up the tube against gravity.
Capillary depression happens for non-wetting liquids (e.g. mercury in glass) – the liquid is pulled *down* below the outside level.

The height of capillary rise or depression is given (approximately) by the formula:

$$h = \frac{2\,\sigma\cos\theta}{\rho\, g\, r},$$

where r is the **radius** of the capillary tube and θ is the **contact angle** between the liquid and the tube wall (the angle the liquid interface makes with the wall, measured inside the liquid). For a perfectly wetting liquid like pure water in clean glass, $\theta \approx 0°$ so $\cos\theta \approx 1$. The formula shows h is higher for higher σ (more pull upward), lower density ρ (lighter fluid is easier to lift), and narrower tubes (smaller r gives higher rise). Gravity (g) in the denominator means stronger gravity reduces capillary rise – on the Moon, water would rise higher in the same tube.

Note: Some references use diameter d instead of radius. In those terms, $h = \frac{4\sigma\cos\theta}{\rho g d}$ (since $d = 2r$). Just be cautious – whether the formula uses r or d will change the factor (2 vs 4).

Exam Handbook Search Cues (Not affiliated with or endorsed by NCEES): surface tension; capillary rise; capillary tube; contact angle; meniscus; σ (sigma)

Footnotes:

[^6]: **Units of Surface Tension:** 1 N/m is also 1 J/m² (energy per area). This is because reducing surface area costs energy, so surface tension can be viewed as energy per area. You might see data as e.g. $\sigma_{\text{water}} = 0.073$ J/m^2 which is the same as 0.073 N/m.

[^7]: **Contact Angle Convention:** A contact angle θ is typically measured through the liquid, between the liquid–gas interface and the solid surface. θ < 90° means the liquid wets the surface (curves upward, like water on glass), θ > 90° means non-wetting (curves downward, like mercury on glass). θ = 0° is complete wetting (the liquid film would flatten out on the surface), whereas θ = 180° would be complete non-wetting (extreme case).

[^8]: **When the Formula Breaks Down:** The capillary rise formula assumes a perfectly cylindrical tube and that the effect of the tube's diameter is small enough that the meniscus shape is determined by surface tension and gravity alone. In extremely narrow tubes or porous materials, other effects (like deviation from hydrostatic pressure distribution or contamination affecting θ) can come into play. However, for typical FE exam scales, this formula is a reliable tool.

Variations & Related Info:

- **Capillary Depression:** If θ > 90°, $\cos\theta$ is negative, so the formula gives a negative h. For example, mercury in glass might have θ ~130°, $\cos 130° \approx -0.64$. With mercury's high σ, you might get, say, $h = -5$ mm in a certain tube – meaning the meniscus is 5 mm below the outside level.
- **Typical Values:** For water in a clean glass tube at 20 °C, σ ≈ 0.073 N/m, ρ ≈ 1000 kg/m³. If the tube radius is 1 mm (0.001 m), and θ ≈ 0, $h \approx \frac{2(0.073)(1)}{1000 \cdot 9.81 \cdot 0.001} \approx 0.015\text{ m} = 1.5\text{ cm}$. If the tube is even thinner, r = 0.1 mm, $h \approx 0.15\text{ m} = 15\text{ cm}$. So small capillaries can pull water significantly high. In plants, capillary action in tiny xylem tubes helps water climb from roots to leaves.
- **Surface Tension of common fluids:** Besides water (~0.0728 N/m at 20 °C), note mercury (~0.48 N/m, with a large contact angle on glass causing depression), and organic liquids like gasoline (~0.022 N/m, much lower than water – they spread more easily). The exam might provide σ if needed; otherwise, assume water's if context implies it.
- **Cleaning and contamination:** Surface tension values assume clean fluid and tube. Oil or dirt can change contact angle drastically. (While not an exam issue, a fun fact: if you coat a glass tube with wax, water might *not* climb because it no longer wets the surface.)

Special Notes: In calculations, make sure to use **consistent units** for σ (N/m), ρ (kg/m³), r (m), and g (9.81 m/s²) to get h in meters. If the exam gives diameter, remember to halve it for r in the formula or use the $4\sigma/(\rho g d)$ form directly. Also, be mindful of your **calculator mode** – $\cos\theta$ requires θ in radians or degrees depending on mode. Typically, contact angles given (like 20° or 130°) are in degrees, so ensure your calculator is in degree mode or convert the angle to radians (e.g. 20° = 0.349 rad) before taking cosine. One more thing: Don't confuse surface tension with surface *energy* in the context of thermodynamics (though they are related, the FE won't dive into that nuance). Finally, if you're typing this formula into the calculator, group the numerator and denominator properly: for example, h = (2*0.073*cos(0))/((1000*9.81*0.001)). It's easy to make a parentheses mistake under exam pressure, so write it out clearly.

Equation Passport: Capillary Rise Formula – determines the height a liquid will rise (or fall) in a narrow tube due to surface tension.

Name & Purpose: Jurin's Law (Capillary Rise Equation) – computes the static height difference h between the fluid inside a thin tube and the external reservoir level, caused by surface tension.

Equation: $h = \frac{2\,\sigma\cos\theta}{\rho\, g\, r}$.

Variables:

- h – capillary rise (if positive) or depression (if negative) (m). This is measured from the free surface of the liquid outside the tube up to the inside meniscus. A positive h means the fluid inside is higher than outside.
- σ – surface tension of the liquid (N/m). A higher σ pulls the liquid surface more strongly.
- θ – contact angle between liquid and tube wall (degrees or radians). This reflects how well the liquid wets the surface. $\cos\theta$ effectively scales the component of σ that acts to lift the fluid. $\cos\theta = 1$ for a completely wetting fluid (θ = 0°). $\cos\theta$ is negative if θ > 90° (non-wetting, leading to depression).
- ρ – density of the liquid (kg/m³).
- g – acceleration due to gravity (9.81 m/s² on Earth).
- r – **radius** of the capillary tube (m). (*Be careful*: if you're given diameter d, note that $r = d/2$ and the formula can be rewritten as $h = \frac{4\sigma\cos\theta}{\rho g d}$ to plug d directly.)

Assumptions & Scope: This formula assumes a clean, cylindrical tube and that the meniscus is shaped by a balance of surface tension and weight of the fluid column. It also assumes the tube is sufficiently narrow that capillary effects dominate (in a wide tube, h would be negligible because the weight of fluid grows with area but the lifting force is around the rim). Temperature and purity affect σ and θ, but we normally use standard values or those given in the problem. This equation is derived from setting the upward force from surface tension (around the tube's circumference) equal to the weight of the column of fluid of height h. It's valid for static equilibrium (no flow in/out of tube) and ignores any dynamic effects.

Limit Checks:

- If $\sigma = 0$ (no surface tension, hypothetically), then $h = 0$. The fluid wouldn't rise at all – no "pull" at the interface.
- If the fluid completely wets the surface (θ = 0, cosθ = 1), you get maximal rise. If it's perfectly non-wetting (θ = 180°, cosθ = -1), the formula gives a negative h (drop) of the same magnitude – meaning the fluid level inside will drop below outside by that amount.
- As $r \to 0$ (extremely narrow tube), $h \to \infty$ theoretically. In reality, very narrow tubes will pull fluid very high (this is how trees transport water to great heights – effectively a network of tiny capillaries).
- As ρ increases (heavier liquid), h decreases – e.g. mercury (13.6x denser than water) doesn't rise, it falls.
- If gravity were smaller (e.g. on the Moon, g ≈ 1.62 m/s²), h would be about 6 times larger for the same tube and liquid, since it's easier to lift the fluid.

Use vs. Alternative Approaches: Use this direct formula for quick calculation of capillary rise in a tube. If you forget the formula, you can derive it by balancing forces: upward force $F = \sigma(2\pi r)\cos\theta$ (surface tension around circumference, pulling up) and set $F =$ weight of fluid column $= \rho g(\pi r^2 h)$, then solve for h. That derivation lands you here. This formula is a specific application of general fluid statics and surface tension principles. There isn't a simpler alternative for arbitrary radius – this *is* the go-to equation. But if the problem is conceptual, sometimes you just reason: "smaller tube → higher rise" without plugging numbers.

Common Exam Pitfalls:

- **Using diameter instead of radius (or vice versa):** This is the #1 mistake. If the problem says the tube has a diameter of 2 mm, your r is 1 mm (0.001 m). Plugging 2 mm as r would double your computed h. Double-check whether you have r or d.
- **Angle confusion:** If a problem gives the contact angle, use its cosine in the formula. If water wets the tube (say θ = 0 or a small angle), cosθ ≈ 1. If a contact angle is given like 60°, that's quite high (not strongly wetting), so expect a cos(60°)=0.5 factor – meaning only half the theoretical maximum rise. Also, ensure your calculator is in the correct mode (deg/rad) as mentioned. It's easy to accidentally compute cos(60) in radian mode and get nonsense.
- **Unit mix-ups:** Make sure σ is in N/m. Sometimes surface tension might be given in dynes/cm in older references (e.g. water ~72 dynes/cm). 1 dyne/cm = 0.001 N/m. If you see a small number like 0.072 and wonder if it's N/m or something else, context clues: water's 0.072 N/m = 72 dynes/cm, same thing. ρ in kg/m³, r in m, g in m/s². If you stray from SI, say r in mm, you *must* convert or you'll get h in mm of fluid (which might be fine if you're consistent, but better to stick to one system).
- **Misidentifying h:** Remember h is measured from the free surface of the bulk liquid. In a rise scenario, h is how far *above* the outside liquid level the inside climbs. If a question asks "How far above the outside liquid level does the water rise?" – that is exactly h. If it asks "What is the column height in the tube measured from the bottom of the meniscus to the bottom of the tube?" that would be something else (not commonly asked). They typically care about that difference in height (since that's what relates to pressure difference).
- **Neglecting temperature effect on σ:** If a problem explicitly gives temperature, use σ for that temperature (the exam reference has water's σ at various temps if needed). For instance, at 80 °C, water's σ is about 0.062 N/m (lower than 0.073 at 20 °C). It might not be a huge difference, but if precision is needed, be aware.
- **Confusing capillarity with flow in a tube:** Capillary rise is a static phenomenon. If you encounter a very small tube in a flow problem, don't mistakenly use this formula thinking it's a head loss or something. Capillary action is about static equilibrium heights. For flow, you'd look at different equations (like Poiseuille's law for flow in micro-tubes, which is a fluid dynamics topic).

K10.T01.S05 – Using Standard Fluid Property Tables (Water and Other Fluids)

Principle (Property Tables): In the FE exam (and in engineering practice), you won't memorize every property of fluids at all conditions – instead, you'll rely on **standard property tables**. These tables (provided in the exam reference) list values like density, viscosity, vapor pressure, etc., for common fluids (water, air, refrigerants, etc.) at various temperatures or pressures. Knowing how to quickly read and interpolate these tables is a key skill. For example, the FE Reference Handbook includes a table of water properties (density, specific weight, saturation pressure, etc.) at a range of temperatures. You might use it to find the density of water at 60 °C, or the saturation (vapor) pressure at 25 °C (which is useful to know if cavitation might occur in a pump).

In this subtopic, we focus on water as a prime example, since water is by far the most commonly referenced fluid in mechanical engineering problems. Other fluids like air have tables too (often in the Thermodynamics section of the handbook), but many times air is assumed ideal gas (so you use equations instead of tables). Water, however, especially for liquid phase properties, you'll often use tables.

Units and data sources: In the table above, temperature is in Celsius (°C). Density is in kg/m³. Dynamic viscosity in Pa·s. Kinematic viscosity in m²/s. Vapor pressure is the saturation pressure of water at that temperature, in kPa (this is the pressure at which water boils at that temp). These values are at **1 atm pressure** for the liquid phase properties. The data is drawn from empirical measurements (the FE Handbook's tables are sourced from standard references like steam tables for water). Remember, this table is not something to memorize – the exam gives it to you. But you *should* memorize approximate values for quick sanity checks: e.g., water density ~1000 kg/m³, viscosity ~1* 10^{-3} Pa·s at room temp.

Typical exam uses:

- **Finding ρ or ν for calculations:** Many fluid problems require density (ρ) – for instance, computing a hydrostatic pressure difference $\Delta P = \rho g h$ or a buoyant force. If the problem says "oil with SG 0.85," you can find ρ = 0.85×(water's 1000) = 850 kg/m³ directly. But if it says "water at 80 °C," you'd ideally get ρ from the table (which might be slightly less than 1000, here ~971 kg/m³). For viscosity-dependent calculations (like Reynolds number $Re = \rho V L/\mu$ or laminar flow head loss using the Hagen–Poiseuille equation), you'll need μ or ν at the given temperature. The exam handbook provides those, so practice quickly locating "Viscosity of water" at the temperature.

- **Saturation pressure (Pvap):** If a question involves cavitation (like "what's the maximum height you can suck water up a straw at 25 °C?" or "will water at 50 °C cavitate at a pump suction of 80 kPa absolute?"), you need the vapor pressure. From the table, at 25 °C water's Pvap ~3.17 kPa (not in our small excerpt, but known), and at 50 °C ~12.3 kPa. You'd compare that to the pressure in the system. Being able to find Pvap in the table quickly is important for such problems.

- **Thermodynamics crossover:** Sometimes mechanical FE questions (especially in thermo/heat transfer) require properties like specific heat or thermal conductivity of water/air. Those are in separate tables/sections. But for fluid mechanics, density and viscosity (and occasionally bulk modulus or surface tension) are key.

Common pitfalls:

- **Mixing up columns:** Make sure you know what each column represents. It's easy under time pressure to grab the wrong number (e.g., take vapor pressure when you meant viscosity). The exam tables are clearly labeled, so double-check headings.

- **Unit confusion:** The handbook might list viscosity in unusual units as well (like mm²/s for kinematic viscosity, which is common in some tables as cSt, centistokes). Always convert to SI units that your formulas expect. For instance, 1 cSt = 1 mm²/s = 1×10^{-6} m²/s. If the table gave ν = 0.5 mm²/s, that is 0.5×10^{-6} m²/s.

- **Interpolation errors:** Linear interpolation is straightforward: $y = y_1 + (y_2 - y_1)\frac{T-T_1}{T_2-T_1}$. Just be careful plugging values. If time is short and you only need a rough estimate, you might round. But also gauge if the property varies nonlinearly – for example, viscosity versus temperature is somewhat exponential. For moderate spans (like 20° difference) linear is fine; for larger, be cautious. The FE exam probably won't demand super precise interpolation; usually if they expect an interpolation, the range is small or the answer tolerance is wide.

- **Choosing which table:** Water, in particular, has different tables for saturated (boiling) properties vs subcooled (liquid) properties. The snippet above is for liquid water at 1 atm. If you have water at 120 °C at 1 atm, that's actually not liquid – it would boil (because 1 atm boiling point is 100 °C). So don't use the liquid table blindly for 120 °C; you'd need steam tables or realize the scenario (e.g., maybe it's pressurized liquid water above 100°C, then a compressed liquid table or interpolation in steam tables is needed – likely beyond FE scope unless given). In summary: ensure the conditions make sense for the table you use. If you're dealing with water at 200 °C in a pressurized system, use the compressed liquid or saturated tables as appropriate (the exam would guide you to the right info).

- **Forgetting to use the table altogether:** Occasionally students try to recall or approximate properties when the table is right there to give an accurate value. Use the reference – that's what it's for. For instance, if asked "what is the density of water at 80 °C?", don't just say ~1000 kg/m³ out of habit; check the table (it might be around 972 kg/m³). A small difference can matter in precise calculations like pump head or buoyancy if the answers are close.

Special Notes:

- On your exam reference, *tab mastery is gold*. Practice flipping (or electronic searching) to the fluid properties section quickly. Know that water properties might appear both in the fluid mechanics section and the thermodynamics section (steam tables). The index can help (search "water" or "properties"). - The FE Handbook often has a separate section for **"Thermophysical properties of common substances"** – water, air, etc. These include density and viscosity over ranges. There's also usually a table for **saturated water** (boiling point vs pressure, etc.), which is more for thermo questions. - If you're using the on-screen PDF on exam day, remember you can hit Ctrl-F (or the search function) and type "viscosity 20°C" or similar to jump to these values. They often highlight keywords like "Water – Density" etc., to make searching easier. For example, searching "1000 kg/m3" might jump you to water's density.

- **Practice Example:** Let's say a question asks: *"Calculate the Reynolds number for water at 20 °C flowing in a 5 mm diameter pipe at 0.2 m/s."* You'd need ρ and μ for water at 20 °C. From the table: ρ ≈ 998 kg/m³, μ ≈ 1.0×10^{-3} Pa·s. Then $Re = \frac{\rho V D}{\mu} = \frac{998 \cdot 0.2 \cdot 0.005}{1.0\times10^{-3}} \approx 998 \cdot \frac{0.001}{1.0\times10^{-3}}$ (since 0.2*0.005 = 0.001) = 998. So Re ~ 1000 (laminar in this tiny pipe). The key was knowing where to get ρ and μ quickly – with practice, that's seconds of effort.

In summary, become familiar with the structure of the fluid property tables in your reference. They're a treasure trove of answers waiting to be used. A savvy examinee uses them to avoid guesswork and to double-check that their computed values make sense (e.g., if you calculate a density that doesn't match the table by a wide margin, something's off).

Table Passport: Water Property Table Usage

Table Title & Purpose: *Liquid Water Properties vs Temperature* – Helps you find accurate values of density, viscosity, and saturation

pressure for water at different temperatures. This supports decisions like computing buoyancy (needs density) or checking for cavitation (needs vapor pressure).

How to Read & Interpolate: Identify the known state (e.g. temperature). Read across that row for the property you need. If the exact temperature isn't listed, perform a linear interpolation between neighboring rows. For instance, for 30 °C, interpolate between 20 °C and 40 °C entries. The tables are usually in increments (10° or 20°). Interpolation is typically linear for small gaps and acceptable for exam accuracy. Never try to use the table beyond its range – if you need a value outside, look for another table or formula.

Units & Source: In our example table, units are SI. Always confirm units from the table header. (The FE Handbook will list them explicitly.) The table data is experimentally based; it's essentially a condensed form of comprehensive steam tables (for water) or NIST property data. It's been vetted for engineering use – you can trust these values. Remember that the table provided in the exam is not an exact copy of any copyrighted source but a compilation for exam reference (hence the "not affiliated with NCEES" note in our book's context).

Typical Exam Moves:

- **Look-up:** Given a temperature (or sometimes pressure), go to the table and grab density (for a hydrostatics or buoyancy problem) or viscosity (for a flow problem).
- **Interpolate:** If the value falls between table entries, do a quick interpolation. The FE exam often chooses nice round values or expects approximate answers, so being within a few percent by linear interpolation is fine.
- **Compare with other data:** Sometimes you might use multiple properties. E.g., find water's vapor pressure at 60 °C to see if a pump inlet pressure is above that (to avoid cavitation).
- **Cross-check SG or other given data:** If a problem gives specific gravity of a fluid, you can multiply by water's density from the table at that temperature to get that fluid's density. Similarly, if a question tells you "kinematic viscosity = 1 cSt" you recognize that as water's order of magnitude (since 1 cSt = 1×10^{-6} m²/s, which water has at ~20°C).

Common Pitfalls:

- **Reading wrong row/column:** Under time pressure, it's easy to accidentally read, say, the 80 °C row when you meant 60 °C, or grab the value from the "ν" column when you wanted "μ". Slow down for a couple seconds to verify you have the correct intersection.
- **Failing to adjust units:** If the table uses °F or provides an alternate unit (some tables list lbm/ft³ alongside kg/m³, or viscosity in centipoise alongside Pa·s), stick to one unit system. Convert if necessary. The exam's reference is mostly SI for consistency, but USCS equivalents might be given parenthetically or in a separate column. Choose the right one for your calculation.
- **Interpolating over a phase change:** As noted, don't interpolate liquid water properties across 100 °C at 1 atm – water changes phase there. Use saturated water/steam data for boiling/condensing scenarios. This is more of a thermo consideration, but it could appear if a fluid mechanics problem strays into that territory (like computing the collapse pressure of a vapor bubble at a given temperature).
- **Using outdated memory:** Perhaps you remember "water's density is 1000 kg/m³" and "viscosity 1 cP" from general knowledge. That's fine for rough estimates, but if the problem expects an answer using the actual value at an elevated temperature, and you stick with 1000, you might be off. Always consider whether the problem wants you to use the table value.
- **Not checking the table index:** If you're frantically scanning the handbook and can't find the water table, use the index or search feature. It might be under "Fluid Properties" or "Thermodynamics – Properties of Saturated Water" etc. Knowing the exact section title or page comes in handy.

By mastering property tables, you essentially have a shortcut to many otherwise tricky problems. It's like having a multi-purpose tool – instead of calculating something from scratch (or worse, guessing), you pull data that the exam freely gives you and apply it. Practice a few scenarios of reading values and you'll become both faster and more confident.

Topic 02 - Fluid Statics

Topic Introduction: Fluid statics deals with fluids at rest and the forces and pressures in such fluids. On the FE Mechanical Exam, you'll encounter questions where you must compute pressures at certain depths, compare readings on manometers, determine forces on submerged surfaces (like dam gates or tank walls) and locate their line of action, or apply Archimedes' principle to find buoyant forces on objects. Mastering fluid statics is important because these problems are fundamental and often straightforward if you know the right formulas. Typical question scenarios include finding the pressure at a given depth below a free surface, using a U-tube manometer to find pressure differences, calculating the hydrostatic force on a flat plate and where it acts, or deciding if an object will float or sink by comparing its weight to the buoyant force. The key is recognizing which principle to use and applying it with correct units and an understanding of gauge vs. absolute pressure.

K10.T02.S01 – Hydrostatic Pressure Distribution

Principle Introduction – Static Fluid Pressure Variation: In a static fluid (no motion), pressure increases with depth because of the weight of the fluid above each point. The deeper you go, the more fluid is stacked above, and thus the higher the pressure. Key points to build intuition include:

- **Linear increase with depth:** For incompressible fluids, pressure changes linearly with vertical depth. If you move downward by a distance h in a fluid, the pressure increases by an amount proportional to h.
- **Reference pressure:** If you know the pressure at some reference level (for example, the surface where the pressure might be atmospheric), you can find the pressure at any other depth by adding or subtracting the change due to the fluid column in between.
- **Independent of shape:** This pressure-at-depth relationship doesn't depend on the container's shape or the horizontal extent of the fluid; it only depends on vertical distance. Even if you swim under a wide ocean or in a narrow well, at the same depth h the pressure increase from the surface will be the same (given the same fluid and gravitational acceleration).
- **Gauge vs. absolute:** Often we take the pressure at the free surface as atmospheric pressure. If we treat that surface pressure as the zero of gauge pressure, then the gauge pressure at depth is simply $\rho\, g\, h$. To get absolute pressure at depth, you would then add atmospheric pressure back in. In formula form, if p_0 is surface pressure (e.g. atmospheric) and h is depth below that surface, pressure at that depth is higher by $\rho\, g\, h$.

Equation Passport – Hydrostatic Pressure Equation – calculates the pressure at a given depth in a static fluid (weight of fluid column over a unit area):

$$p = p_0 + \rho\, g\, h$$

- $\boldsymbol{p}$ – Pressure at the point of interest, at depth h below the reference level (Pa (Pascal) in SI, or any consistent pressure unit).
- $\boldsymbol{p_0}$ – Reference pressure at the free surface or starting level (Pa). Often this is atmospheric pressure if the fluid is open to air. If we take p_0 as atmospheric, then p calculated is absolute pressure at depth; if we take $p_0 = 0$ (gauge at surface), then p comes out as gauge pressure.
- $\boldsymbol{\rho}$ – Fluid density (kg/m³). Assumed constant (incompressible fluid) for this linear relation to hold.
- $\boldsymbol{g}$ – Acceleration due to gravity (m/s²). On Earth's surface $g \approx 9.81\ \mathrm{m/s^2}$ (approximately $32.2\ \mathrm{ft/s^2}$ in US units). Use the value provided in the problem if given (sometimes 9.80 or 9.81 m/s²).
- $\boldsymbol{h}$ – Vertical depth below the reference level (m). It's crucial that h is measured vertically downward, in the direction of gravity, between the two points whose pressure difference you're considering.

Assumptions and Scope:

- **Fluid at rest:** This formula assumes the fluid is static (no flow, no dynamic effects). There are no acceleration or velocity terms – just hydrostatic pressure due to weight. (If the fluid were moving or there were pumps, you'd need more complex equations like Bernoulli's equation, but for pure vertical columns at rest, hydrostatics applies.)
- **Incompressible fluid:** Density ρ is taken as constant with depth. For liquids like water or oil at moderate depths, this is valid. (If you were dealing with gases, they compress with pressure so the relationship isn't strictly linear over large altitude changes, but for small height differences you might still use it as an approximation or use a different formula.)
- **Uniform $\boldsymbol{g}$:** We assume g is constant over the height h (true for small vertical distances on Earth).
- **Flat horizontal layers:** We assume the pressure is constant at all points at the same horizontal level in a connected fluid (Pascal's law). So p_0 applies across the free surface, and p applies across any horizontal plane at depth h.

Limit Tests (Sanity Checks):

- If $h = 0$ (no depth difference), then $p = p_0$. That makes sense: at the reference level itself, the pressure change should be zero, so the pressure is just the reference pressure.
- If $\rho = 0$ (imagine a vacuum or no fluid), then $p = p_0$. No fluid means no weight to increase pressure, again sensible.
- As h increases, p increases without bound linearly. For example, going twice as deep doubles the pressure increase. There's no sudden surprises—just a linear growth. This helps catch mistakes: if you accidentally used diameter or area instead of height in the formula, or used h in the wrong units, results would look off (e.g., using centimeters instead of meters would under-predict p by a factor of 100).

Use vs. Sibling Equations: Use this hydrostatic pressure equation whenever you need to relate pressures at two elevations in a static fluid. It is the basis for many other tools (like manometers or barometers). Do **not** confuse it with the **Bernoulli equation**, which includes kinetic energy terms for moving fluids. If there's no flow

and you're literally just looking at fluid columns or depths, stick to $p = p_0 + \rho g h$. If flow is involved (velocity, heads, etc.), then Bernoulli's or energy equations come into play, not plain hydrostatics.

Common Exam Traps:

- **Gauge vs. absolute mix-ups:** One of the most frequent mistakes is confusing gauge pressure and absolute pressure. Remember, if p_0 is atmospheric pressure and you plug in numbers (with h in meters, ρ in kg/m³, g in m/s²), the $\rho g h$ term gives you the *gauge* pressure (pressure above atmosphere). To get absolute pressure at that depth, add atmospheric pressure. Conversely, if the problem asks for gauge pressure, you might set $p_0 = 0$ (taking atmospheric as baseline) and report $p = \rho g h$. Always clarify what the problem is asking for and what reference is used.
- **Unit consistency:** Ensure h is in meters (if using SI) or feet (if using USCS) to match the units of g. If h is given in, say, centimeters or inches, convert to the base unit first. Likewise, if using ρ in kg/m³ and g in m/s², the result will be in Pascals (N/m²). If you accidentally left h in cm, you'd be off by a factor of 100. A quick check: the pressure increase $\rho g h$ for water (~1000 kg/m³) per meter is about 9.8×10^3 Pa (~9.8 kPa, which is roughly 0.1 atm per 10 m). So if you got something wildly different, double-check units.
- **Using the wrong value of g or forgetting g:** In US customary units, sometimes people mix mass and weight. If you use ρ in slug/ft^3 and h in ft, you must use $g \approx 32.2\ \text{ft/s}^2$ to get pressure in lbf/ft² (psf). Alternatively, many prefer to use the fluid's **specific weight** $\gamma = \rho g$ directly: for water, $\gamma \approx 62.4\ \text{lbf/ft}^3$, so the pressure in psf can be found by γh (with h in ft). Forgetting the g factor or the difference between ρ and γ leads to errors. For example, using 1000 (kg/m³) directly as if it were weight density in SI (which it's not) would omit g and underpredict pressure by a factor of 9.81.
- **Sign conventions:** The formula $p = p_0 + \rho g h$ assumes you're increasing depth (h positive downward). It inherently comes from integrating $dp/dz = -\rho g$ (with z upward). If you go down, pressure increases (plus sign with h). Some confusion can arise if you define upward as positive; just remember: deeper means more pressure. If you accidentally subtract when you should add, you might end up with unphysical negative pressures in a depth calculation.

Exam Handbook Search Cues (Not affiliated with or endorsed by NCEES): *pressure variation; hydrostatic pressure; pressure head; fluid statics* (These are keywords to quickly find relevant formulas in the exam reference handbook.)

Footnotes:

- It's common in problems for the fluid surface to be open to air, thus p_0 is atmospheric pressure. In many practical cases on the FE exam, you might set atmospheric pressure as 0 (gauge) to simplify; just be mindful if the final answer needs to be given as an absolute pressure (then add 101.3 kPa, or 14.7 psi, etc., to your gauge result).
- The formula can be rearranged to $p - p_0 = \rho g h$. The term $\rho g h$ itself is sometimes called **hydrostatic pressure** or **pressure head** (with h being the head, in units of length). In the exam reference, you might see "head" used (e.g. converting pressure to an equivalent column height of fluid: $h = \frac{p - p_0}{\rho g}$). Remember 1 psi corresponds to about 2.31 feet of water column, and 1 atm is about 33.9 ft of water or 10.3 m of water. These conversions can appear if you need to switch between pressure units and height of fluid.
- The hydrostatic formula is the basis for many devices and concepts: **manometers** (coming up next) use columns of fluid to measure pressure differences directly via $\rho g h$, and **barometers** measure atmospheric pressure via the height of a mercury column. When in doubt on a pressure-at-depth problem, start with this formula and input what you know.

Variations and Related Forms: If you have multiple fluid layers (say oil on top of water), you can extend the hydrostatic concept by adding up the pressure contributions from each layer: $p_{\text{bottom}} = p_{\text{top}} + \rho_{\text{oil}}\, g\, h_{\text{oil}} + \rho_{\text{water}}\, g\, h_{\text{water}} + \cdots$. Each homogeneous layer's thickness contributes $\rho g h$ for that layer. Also, note ρg is the fluid's **specific weight** γ. You might see the formula written as $p = p_0 + \gamma h$ in some references, especially for USCS units (where γ might be given in lbf/ft³). Both forms are equivalent ($\gamma = \rho g$). Finally, in fluid statics, sometimes pressure is described in terms of **head** (height of fluid). For example, a pressure of 50 kPa in water corresponds to a head of $h = \frac{50{,}000\ \text{Pa}}{(1000\text{kg/m}^3)(9.81\text{m/s}^2)} \approx 5.1$ m of water. This is useful if an exam question gives a pressure in obscure units by referencing a fluid column height (e.g. "20 cm of mercury" – you'd convert that to pressure via $\rho g h$).

Special Notes (Calculator Tips): This formula is straightforward to use on any calculator – it's just multiplication and addition. The main "special" consideration is unit conversion: for example, if h is given in mm or ft, convert to m (for SI) or to ft (for US units) before plugging in. If you're using an advanced scientific calculator, you might store constants like g or common densities to speed up multiple calculations. But generally, these computations are direct. One thing to be cautious about: if using US units and you're more comfortable using specific weight γ, that's fine (e.g. use 62.4 for water, so $p(\text{psf}) = 62.4 \times h(\text{ft})$). If you use density in slugs/ft³ (~1.94 for water) and g, just ensure you include g properly. The allowed exam calculators (Casio fx-115/fx-991, HP 33s/35s, TI-30X/36X) can all handle this easily; just be meticulous with entering scientific notation for ρ if needed (like oil might be $900\ \text{kg/m}^3$, which you enter as 900, not 9.00 x 10^2 which is the same thing anyway).

Explanation & Analysis (Step-by-Step): The hydrostatic pressure equation comes from a simple equilibrium of forces in a fluid column. Imagine a tiny imaginary column of fluid of cross-sectional area 1 m², extending from the free surface down to depth h. That column has a volume of $1 \times h = h$ m³, and thus a mass of $\rho \times h$ (since ρ kg in each cubic meter). The weight of that column is $\rho g h$ (newtons). At the bottom of this column, that weight is supported by an increase in pressure p compared to the top. Pressure is force per area, and our area is 1 m², so the force at the bottom due to pressure is $p \times 1$. For that to balance the weight of the fluid above, p must equal $\rho g h$ (if we take the top pressure as zero gauge). This is essentially why $p = \rho g h$ (gauge). If the fluid at the top has some initial pressure p_0 (like atmospheric pushing down on the surface), that gets transmitted throughout the fluid (Pascal's principle) and adds on top of the $\rho g h$. Hence $p = p_0 + \rho g h$. In practical terms, this formula means you can take any two points in a connected fluid and relate their pressures by the vertical

distance between them. For example, if you have a tank and want the pressure at a point 3 m below the water surface, and the surface is open to air ($p_0 = 101.3$ kPa absolute, say), then $p_{\text{absolute}} = 101.3\text{kPa} + (1000\text{kg/m}^3)(9.81\text{m/s}^2)(3\text{m}) \approx 130.7\text{kPa}$. The gauge pressure at that depth would be about 29.4 kPa (since that's how much above atmospheric it is). Term by term, p_0 is your starting pressure (think of it as the baseline present even with no fluid depth), and $\rho\, g\, h$ is the contribution from the fluid's weight. $\rho\, g$ is sometimes called **specific weight** of the fluid (with units N/m³ or lbf/ft³), and multiplying it by h (a length) gives pressure. A common mistake is to think that a wide container has "more pressure" at the bottom than a narrow tube at the same depth – not true! The shape doesn't matter; only depth does. This non-intuitive fact is sometimes called the "hydrostatic paradox," but it's a confirmed principle: pressure at a depth depends only on vertical depth, not on the volume of fluid above. As long as you remember that and use this equation carefully with consistent units, you'll handle FE questions on fluid pressure with ease.

K10.T02.S02 – Manometers

Principle Introduction – U-Tube and Differential Manometers: A *manometer* is a simple device that uses columns of fluid to measure pressure differences. The classic manometer is a U-shaped tube partially filled with a liquid (often mercury or water or some gauge fluid). One end of the tube is connected to a point where we want to know the pressure (say, a pipe or tank), and the other end is connected to a reference pressure (often the atmosphere, or another point). Because the fluid in the manometer is static, the pressures at points along a continuous fluid must balance out. Key intuitive points:

- **Column balance:** In a U-tube, fluid will adjust its heights until pressure forces balance. The pressure at any given horizontal level in the same connected fluid is the same. So if you pick a point at the same elevation on both legs of the manometer, the pressure there must be equal (assuming it's the same fluid at that level). This is how we relate the pressures at the two ends via the intermediate fluid columns.
- **Adding $\boldsymbol{\rho\, g\, h}$ increments:** When moving downward in a fluid, pressure increases by $\rho\, g\, \Delta\, h$. When moving upward, pressure decreases by that amount. To solve a manometer, you essentially start at one end's pressure, move through the fluids (adding or subtracting $\rho\, g\, h$ as you go down or up each column segment), until you get to the other end. The sum of those changes will relate the two end pressures.
- **U-tube with one fluid:** If the manometer is filled with a single fluid (say water) and both ends are exposed to the same fluid, then a difference in height $\Delta\, h$ directly means a pressure difference $= \rho\, g\, \Delta\, h$. In fact, a simple U-tube open to the air on both ends will level out ($\Delta\, h = 0$) because both ends at atmosphere means no pressure difference to hold a column imbalance. If one side is connected to a pressurized system, the fluid will rise on the lower-pressure side.
- **Multiple fluids (differential manometer):** Often, the manometer fluid is different from the fluid whose pressure we measure (example: measuring pressure in an air duct using water, or in a water pipe using mercury). If one fluid is heavier, the columns won't move as much for a given pressure difference. The general rule is: the pressure difference between the two ends equals the difference in weight of the column of fluids. Practically, this means you take the difference in fluid densities into account.
- **Manometer vs. mechanical gauges:** Unlike a mechanical pressure gauge, a manometer gives a visual height difference. On exam day, you might be given a U-tube drawing with height readings, and you must compute the pressure difference or an unknown pressure. Manometers are reliable for small to moderate pressures; very large pressures would require very tall manometer columns (impractical), which is why we use them for calibration or differential measurements typically.

Equation Passport – Manometer Pressure-Difference Relationship – relates the pressure difference between two points to the heights of fluid columns in a U-tube (with possibly different fluids):

For a simple U-tube manometer connecting two points (A and B) and containing two fluids, the pressure difference can be expressed as:

$$\Delta p = (\rho_{\text{heavy}} - \rho_{\text{light}})gh$$

Here $\Delta\, p$ is essentially $p_A - p_B$ (the difference between the pressures at the two connected points, assuming point A is on the side with the heavier column). In a common case, point A might be a pressurized pipe and point B is the atmosphere (so $\Delta\, p$ would be the gauge pressure in the pipe).

- $\boldsymbol{\Delta\, p}$ – Pressure difference between the two connected points (Pa, or any consistent pressure unit). You should carefully assign the sign based on which side is higher pressure. This formula as written gives the magnitude of $p_A - p_B$ when the heavy fluid column is higher on B's side (meaning A is higher pressure).
- $\boldsymbol{\rho}_{\text{heavy}}$ – Density of the heavier manometer fluid (kg/m³). For example, if using mercury to measure pressure in an air or water system, mercury is the heavy fluid.
- $\boldsymbol{\rho}_{\text{light}}$ – Density of the lighter fluid on the other side (kg/m³). This could be the fluid in the pipe if different, or if the other side is open to air, it would be air's density (which is so small compared to liquid that you might approximate $\rho_{\text{light}} \approx 0$). In many manometer problems, one side is open to atmosphere (light fluid = air) and the heavy fluid is something like water or mercury, so this term effectively drops out, leaving $\Delta\, p \approx \rho_{\text{heavy}}\, g\, h$. But don't ignore it if the problem explicitly involves two liquids (e.g. a "differential manometer" connecting two liquid tanks).
- $\boldsymbol{g}$ – Acceleration due to gravity (m/s²), as usual. Use 9.81 m/s² (or 32.2 ft/s²) unless instructed otherwise.
- $\boldsymbol{h}$ – Height difference between the manometer fluid columns (m). This is typically the *vertical* difference in levels of the fluid in the two arms of the U-tube (sometimes denoted $\Delta\, h$). If one side of the manometer is higher than the other, h is that difference. Often, you measure this as the distance between the two fluid meniscus levels.

Assumptions and Scope:

- **Hydrostatic conditions:** The manometer fluids are static (no flow through the U-tube), so we can apply hydrostatic balance. There's no acceleration or capillary effects considered (we assume any capillary rise is negligible

unless the tube is extremely small diameter; typically ignored in exam unless stated).

- **Same reference level:** The derivation of the formula assumes that at some horizontal plane in the U-tube, the pressure on both sides is the same (usually at the interface of fluids or at the bottom of the U). We typically start at one end (pressure p_A at point A), go down to some common level adding $\rho\ g\ h$ for each descent, and then go up on the other side subtracting $\rho\ g\ h$ to reach the other end's pressure p_B. The formula given is a simplified result for common configurations. It assumes the geometry is such that one continuous heavy fluid column forms the main difference.
- **Small height approximation for gas:** If a gas (like air) is one of the fluids, its density is so low that any height difference in the gas itself can be neglected for computing pressure changes (unless heights are extremely large). We assume the gas column's weight is negligible unless the problem states otherwise.
- **No mixing of fluids:** The fluids are immiscible (they don't mix), forming clear interfaces. Each fluid's density stays constant throughout its column segment. Temperature is assumed constant so densities don't change with temperature in the context of the problem.

Limit Tests (Sanity Checks):

- If the two fluids have equal density ($\rho_{\text{heavy}} = \rho_{\text{light}}$), then $\Delta p = 0$ for any h in the formula. That makes sense: if it's the same fluid on both sides of a U-tube and you somehow had different heights, they wouldn't actually stay that way – the fluid would slosh until levels equalize (no pressure difference can be sustained just by geometry if densities match).
- If $h = 0$ (the manometer shows level equal on both sides), then $\Delta p = 0$. No pressure difference, which fits the expectation that equal heights mean balance.
- If one side is open to atmosphere and the heavy fluid is, say, mercury, then $\rho_{\text{light}} \approx 0$. The formula reduces to $\Delta p \approx \rho_{\text{Hg}}\ g\ h$. For example, a 0.1 m (100 mm or about 4 inches) difference in a mercury manometer corresponds to $\Delta p \approx 13550 \times 9.81 \times 0.1 \approx 13{,}300$ Pa $=$ 13.3 kPa. That's about a 1.93 psi difference for about 4 inches of mercury (since mercury is very dense, small height gives significant pressure). If we did the same 0.1 m height with water (which is lighter), using $\rho_{\text{water}} = 1000$, we'd get ≈ 9810 Pa (1.42 psi). The heavier the fluid, the more pressure difference for the same h – which is why mercury is preferred for compact manometers. This check helps ensure you plug densities correctly: if you accidentally used the wrong fluid density, results might be off (e.g., using water density for mercury or vice versa would give an absurd mismatch: 100 mm of mercury is a lot of pressure, 100 mm of water is relatively little).

Use vs. Sibling Equations: The manometer equation is really just an application of the hydrostatic formula, but applied piecewise for different fluids. Use the manometer relationship when you have a U-tube or multi-fluid arrangement and need to find a pressure difference or an unknown pressure. An alternative approach is writing out hydrostatic balance step by step (which is always valid). For example, you can say: starting at pressure p_A on side A, go down/up and equate to side B's pressure. This yields the same result as the compact formula. **Do not** confuse a manometer reading with a direct single $\rho\ g\ h$ unless it's a simple case – remember if the fluids differ, you must account for both. Also, don't mix this up with **barometer readings** (barometer is a special case of a manometer, one end in vacuum; we'll discuss that next). If fluids are moving or there's a flow velocity, manometers might not hold (you'd use stagnation pressure and Pitot tubes for that, which is another topic), but for static or steady situations, manometers are ideal.

Common Exam Traps:

- **Using the wrong fluid density:** A very common mistake is to plug in the wrong ρ. For instance, if you have water in one side and mercury in the U-tube, when computing the pressure difference you *must* take the difference in densities $(\rho_{\text{Hg}} - \rho_{\text{water}})$. If you forget to subtract the lighter fluid's density, you might just do $\rho_{\text{Hg}}\ g\ h$ which overshoots the pressure difference (because it assumes vacuum or negligible fluid on the other side, effectively). Always identify which side is which: heavy fluid vs. light fluid. If one side is open to air, $\rho_{\text{light}} \approx 0$ so it's fine to drop it; but if one side is, say, oil (density 800 kg/m³) and the manometer fluid is water (1000 kg/m³), you must use $(1000 - 800)$ in kg/m³ for the density difference.
- **Sign confusion (which side is higher pressure?):** Manometer formulas can be derived in different sign conventions. It's easy to mix up which pressure is larger. A good rule: The side where the fluid column is lower (pushed down more) is the side with higher pressure pushing on it. In our formula form, we assumed $\rho_{\text{heavy}} > \rho_{\text{light}}$ and that the heavy fluid is pushed down on the high-pressure side. If you set it up consistently, you'll get a positive Δp. But if you accidentally invert it, you might get a negative result or just identify the wrong side as high. It helps to sketch: mark p_A on one side, p_B on the other, and note which column went up or down. Then write: $p_A = p_B + (\rho_{\text{heavy}} - \rho_{\text{light}})gh$ if A side is higher pressure. Double-check: if ρ_{light} is negligible, this says $p_A = p_B + \rho_{\text{heavy}}\ g\ h$. That would mean A (the connected side) has pressure equal to atmosphere plus something – that's correct if A is the pipe and B is atmosphere. A lot of mistakes can be avoided by logically thinking: "Higher column on side B means side A pressure was higher to push it down."
- **Unit errors in reading h:** Manometer readings might be given in mm or cm (especially mercury, often quoted in mmHg). Make sure to convert that to meters (or feet if working in imperial) before plugging into $\rho\ g\ h$. If you see a problem statement like "the mercury manometer shows a 2.5 inch difference," convert 2.5 inches to feet (0.2083 ft) or to meters (0.0635 m) accordingly. This error is similar to the hydrostatic one but worth repeating because manometer differences are often not huge, so being off by a factor of 1000 (mm vs m) will absolutely kill the answer.
- **Neglecting the fluid on both sides (when applicable):** If both sides of a manometer are not open to the same environment (e.g., two tanks with different fluids), you might need to account for both sides' fluid heights. For instance, a differential manometer between two water tanks might have an heavier gauge fluid connecting them. In that case, you'd have contributions from both sides. A mistake would be to only consider one side's column. The general approach (and safest in complex cases) is:

start at one known pressure, traverse through each fluid segment adding/subtracting $\rho\ g\ h$, and set equal to the other side's pressure. This systematic method prevents missing any column.

- **Assuming level reference incorrectly:** You must compare pressures at the same horizontal level. If a problem gives multiple interfaces, ensure you identify a single continuous fluid path to apply the balance. Sometimes a mistake is to try to equate pressures at different levels (which is wrong unless you account for $\rho\ g\ h$ between those levels). Always drop a horizontal line somewhere in the U-tube where the same fluid spans both sides – that's your equal pressure point.

Exam Handbook Search Cues (Not affiliated with or endorsed by NCEES): *manometer; U-tube; pressure difference; gauge fluid* (These terms will point you to relevant manometer equations or diagrams in the reference handbook.)

Footnotes:

- Many manometer problems can be solved by a straightforward formula like above, but if you ever get confused, fall back to first principles: Pick one end (say pressure at A), and move through the tube. For example: "Starting at p_A in the left limb at some level, go down $\Delta\ h_1$ in fluid 1 (add $\rho_1\ g\ \Delta\ h_1$), then cross into fluid 2 at the bottom (pressure continuous), go up $\Delta\ h_2$ in fluid 2 (subtract $\rho_2\ g\ \Delta\ h_2$), arrive at the right limb at pressure p_B at the same level." Set that equation up: $p_A\ +\ \rho_1\ g\ \Delta\ h_1\ -\ \rho_2\ g\ \Delta\ h_2\ =\ p_B$. It's essentially the same as the provided formula when simplified for a typical symmetric U-tube scenario. This method works for any combination, even more complex ones.
- If the manometer is inclined (you might see an inclined manometer where one leg is tilted to spread out the fluid for finer measurement), remember that it's the **vertical** difference in height that matters for pressure, not the length along the tube. The problem will typically give you the vertical rise/fall or enough geometry to compute it (e.g., an inclined tube with graduation, you'd multiply reading by sin of angle to get vertical). Keep that in mind: pressure differences correlate to vertical height differences.
- A manometer essentially measures *gauge pressure* if one side is open to atmosphere (since it tells you how much above atmospheric the other side is). If both sides connect to pressurized systems, it measures the difference between those two systems. This is why a "differential manometer" is used to compare two pressures directly. On the exam, if they ask for an absolute pressure using a manometer reading, you'll have to add atmospheric pressure to the gauge difference. For instance, "one side of a U-tube is open (atm), the other is connected to a container. If the fluid height difference corresponds to 5 kPa, what is the absolute pressure in the container?" You'd answer $101.3\ \text{kPa}\ +\ 5\ \text{kPa}\ =\ 106.3\ \text{kPa}$ (assuming atmospheric 101.3 kPa).
- The difference between a *manometer* and a *barometer* (next topic) is essentially what each end is connected to: a barometer is just a manometer with one end sealed as a vacuum (so it measures atmospheric absolute pressure). Recognize that the physics is the same; barometer is a special case.

Variations and Related Forms: You might encounter terms like **piezometer** (a simple vertical tube open to atmosphere used to measure pressure in a pipe – essentially one limb of a manometer; fluid rises to a height where its hydrostatic pressure matches the pipe pressure). Also, **inverted U-tube manometers** exist for measuring small pressure differences in heavier liquids by using a light fluid in the U-tube, but those are less common. The standard U-tube with a heavier fluid is most common. As mentioned, **inclined manometers** spread the column over a length for precision – the calculation still uses vertical height. If multiple fluids stack up (e.g., a three-fluid manometer), just extend the logic: subtract the contributions of each lighter fluid from the heaviest, etc., or do it stepwise. It's rare to go beyond two fluids on the FE exam, though. Typical values to remember: Mercury (Hg) has density around $13{,}600\ \text{kg/m}^3$, so 1 mm Hg corresponds to ~133.3 Pa (this is a known conversion: 760 mm Hg = 101325 Pa). Water is $1000\ \text{kg/m}^3$, so 1 mm H_2O is 9.81 Pa. These can help you sanity-check answers or do quick conversions: e.g. if a problem says "a water manometer shows 4 inches difference," 4 inches is about 101.6 mm, which times 9.81 Pa/mm gives about 997 Pa, roughly 1 kPa (makes sense). If it were mercury, 101.6 mm Hg would be 13,540 Pa (~13.5 kPa). Recognizing these magnitudes is helpful.

Special Notes (Calculator Usage): Solving manometer problems might involve multiple steps of addition/subtraction. Keep track carefully. A neat trick: some students store intermediate results (like $\rho\ g$ values) in the calculator memory. For instance, compute $\rho_{\text{heavy}}\ g$ once and use it to multiply by h. But given the simplicity, it might not save much time unless you have to do it repeatedly. If using an HP 35s or similar RPN calculator, you can enter the h and ρ and g sequentially to accumulate the result. Just be organized: writing down the expression before computing is wise to avoid sign mistakes. The biggest "calculator" note is actually a conceptual one: double-check which side's reading you use as h. If the problem gave two heights (one in each limb relative to some datum), you may need to subtract them to get h. Don't plug in the wrong segment length. The calculators won't warn you if you plug the wrong number – but your brain can, if you visualize the U-tube properly.

Explanation & Analysis (Step-by-Step): Let's walk through how a manometer determines pressure, step by step. Imagine a U-tube manometer: left side connected to a gas tank (point A with pressure p_A we want), right side open to atmosphere (point B at $p_B\ =\ p_{\text{atm}}$). The U-tube contains mercury. Initially, when disconnected, levels are equal. Now we attach the left side to the tank. If p_A is greater than atmospheric, it will push the mercury down on the left, causing it to rise on the right. Eventually it equilibrates: the pressure at the same horizontal level in the mercury (say the bottom of the U) must be equal in both limbs (because it's the same fluid and connected). Now, at equilibrium, the pressure at that bottom level from the left side is p_A transmitted down plus the contribution of the mercury column above that point on the left (if any). On the right side, it's atmospheric pressure plus the mercury column above that bottom point on the right. Write that: moving from point A (gas) down to bottom: pressure increases by $\rho_{\text{Hg}}\ g\ h_{\text{left}}$ (if h_{left} is how far below A the bottom is). On the right, moving from atmosphere down to bottom: increases by $\rho_{\text{Hg}}\ g\ h_{\text{right}}$. At the bottom, pressures equal: $p_A\ +\ \rho_{\text{Hg}}\ g\ h_{\text{left}}\ =\ p_{\text{atm}}\ +\ \rho_{\text{Hg}}\ g\ h_{\text{right}}$. Rearranging, $p_A - p_{\text{atm}} = \rho_{\text{Hg}} g\left(h_{\text{right}} - h_{\text{left}}\right)$. And note $\left(h_{\text{right}} - h_{\text{left}}\right)$ is exactly the difference in column heights h. If left side went down and right went up by that amount, $h_{\text{right}}\ =\ h_{\text{left}}\ +\ h$, so indeed $h_{\text{right}}\ -\ h_{\text{left}}\ =\ h$. So we get $p_A\ -\ p_{\text{atm}}\ =\ \rho_{\text{Hg}}\ g\ h$. This is the gauge pressure in the tank. If the fluid

in the tank wasn't gas but another liquid of significant density, then while going down the left side we would also traverse that liquid: for example, if point A is in water and then mercury starts at the interface, you'd have an extra term for the water segment. The formula would generalize to $p_A + \rho_{\text{water}} g(\text{watercolumndrop}) + \rho_{\text{Hg}} g(\text{mercurydrop}) = p_B + \rho_{\text{air}} g(\text{airdrop})$. Air drop negligible, water drop might exist if levels in water side are at different heights from interface. But if the manometer taps into the side of a tank, the water level in that tank might not change appreciably. In any case, general analysis yields that difference of densities expression. The principle: heavier fluid column on one side balances lighter fluid column plus pressure difference. In analysis terms, each term $\rho\ g\ h$ represents a pressure chunk. The beauty of manometers is that they directly convert a pressure difference into a measurable length h. For the FE exam, you'll usually directly apply $p_{\text{unknown}} = p_{\text{known}} + (\rho g \Delta h)$ with the correct sign and ρ. For example, if a problem says "One side of a U-tube is open, the other attached to a pipe. The fluid is mercury. The mercury column is 6 in. higher on the open side than the side connected to the pipe." You identify that pipe pressure is higher, and you compute $p_{\text{pipe}} - p_{\text{atm}} = \rho_{\text{Hg}} g(0.1524\text{m})$. $\rho_{\text{Hg}} \approx 13550\ \text{kg/m}^3$, so $p_{\text{gauge}} \approx 13550 * 9.81 * 0.1524 \approx 20{,}300\ \text{Pa} = 20.3\ \text{kPa}$. That's the logic. Term-by-term: $(\rho_{\text{heavy}} - \rho_{\text{light}})gh$ is essentially saying "the extra weight of the heavy fluid column compared to the light fluid column is supported by the pressure difference." If ρ_{light} is zero (vacuum/air), it's just the weight of the heavy fluid column. If ρ_{light} is not negligible, part of the column's weight is effectively "cancelled" by the lighter fluid's weight on the other side, hence the subtraction. Always remember that conceptual picture and you'll set up the equation correctly even if you forget the exact formula. The manometer is one of the most reliable and accurate devices because it's literally using fundamental physics (mass of fluid) to measure pressure – just be sure to interpret what the columns are telling you on exam problems.

K10.T02.S03 – Barometers

Principle Introduction – Measuring Atmospheric Pressure: A barometer is basically a manometer designed to measure **atmospheric pressure**. In the traditional **mercury barometer**, a long glass tube is sealed at one end, completely filled with mercury, then turned upside down into a mercury dish so that the open-end stays submerged. The mercury level in the tube drops slightly, leaving a vacuum (or nearly a vacuum) at the top, and then settles at a steady height. That column height corresponds directly to the atmospheric pressure acting on the mercury in the reservoir.

Key points about barometers:

- **Atmospheric pressure support:** The atmosphere (air) has weight, and it exerts a pressure on all surfaces, including the mercury in the reservoir. This pressure is what holds up the mercury column in the tube. The higher the atmospheric pressure, the taller the mercury column it can support.
- **Vacuum above mercury:** In a mercury barometer, the space at the top of the tube is nearly a vacuum (just mercury vapor at a very low pressure). This means the pressure at the top of the mercury column is essentially zero (or the vapor pressure of mercury, which is very low at room temperature). So the pressure at the bottom (which is atmospheric) must be balanced by $\rho\ g\ h$ of the mercury column.
- **Standard atmosphere:** By experiment, at sea level on a "standard" day, atmospheric pressure is about **760 mm of Hg** (mercury) height. This corresponds to about **101.3 kPa** of pressure (which is 101,300 Pa) or **14.7 psi** in imperial units. These are useful reference numbers: they define 1 atm of pressure. If the barometer reads lower (say 700 mm), that means lower atmospheric pressure (perhaps a storm is coming, meteorologically).
- **Other fluids:** You could theoretically make a barometer with water or any other fluid, but mercury is used because it's so dense that 1 atm only requires 0.76 m of column. Water, being ~13.6 times less dense, would require about 10.3 m (33.9 feet) of column – not very convenient for a lab instrument!
- **Pressure units from barometer:** Often pressure is reported as "mmHg" or "inches of Hg" especially in weather or vacuum measurements. These come directly from barometer readings. On the FE exam, you might be given atmospheric pressure in those terms and need to convert to standard units, or vice versa. Understanding that conversion is essentially applying $\rho\ g\ h$.
- **Absolute vs gauge:** A barometer always measures absolute atmospheric pressure, because the reference (top of column) is a vacuum (zero absolute pressure). This is different from most pressure gauges which measure gauge (difference from atmosphere). If you ever see a pressure quoted like "torricelli vacuum of 100 mmHg" or something, it's referencing this idea of measuring below atmospheric. But for this exam, know that barometer gives absolute Patm, which you use as needed for other calculations (like converting a gauge pressure to absolute by adding Patm).

Equation Passport – Barometric Pressure Relation – computes atmospheric pressure from the height of a column of barometer fluid (usually mercury):

$$P_{\text{atm}} = \rho_{\text{bar}}\ g\ h + P_v$$

In most cases we simplify this to $P_{\text{atm}} \approx \rho_{\text{bar}}\ g\ h$ because P_v (the vapor pressure of the barometer fluid at the top) is very small if the fluid is mercury at normal conditions. Let's break it down:

- $\boldsymbol{P}_{\text{atm}}$ – Atmospheric pressure (Pa, or other pressure units). This is the unknown we're measuring, or sometimes given in one unit to convert to another. It is an **absolute** pressure. Standard sea-level value to remember: $P_{\text{atm,sea level}} \approx 101{,}325\ \text{Pa} = 101.3\ \text{kPa}$.
- $\boldsymbol{\rho}_{\text{bar}}$ – Density of the barometer fluid (kg/m³). For mercury, $\rho_{\text{Hg}} \approx 13{,}550\ \text{kg/m}^3$ (it varies slightly with temperature, 13,595 kg/m³ often cited at 0°C). If water were used, $\rho_{\text{H2O}} \approx 1000\ \text{kg/m}^3$. Use the appropriate density for whatever fluid column is mentioned.
- $\boldsymbol{g}$ – Gravitational acceleration (m/s²). Again ~9.81 m/s² for Earth. (Barometer readings historically were done at standard gravity, but minor differences in g with location won't be in exam scope.)
- $\boldsymbol{h}$ – Height of the fluid column (m). This is how high the fluid rises in the barometer tube above the free surface of the reservoir. Often given in mm or inches for mercury. For example, $h = 760\ \text{mm} = 0.760\ \text{m}$ corresponds to about 1 atm for mercury.
- $\boldsymbol{P}_v$ – Vapor pressure of the barometer fluid (Pa). This is the pressure exerted by the tiny amount of fluid that evaporates into the vacuum at the top of the column. For mercury at 20°C, P_v is only about 0.16 Pa – negligible compared to 101,300 Pa of atmosphere. So often we take

$P_v \approx 0$, effectively assuming a perfect vacuum. If using a more volatile fluid (like water), P_v is not negligible (water at 20°C has $P_v \approx 2.3$ kPa, which would slightly reduce the height you'd get for same Patm, but in exam problems unless they specifically go there, you can neglect or they'll mention it). In summary, P_v is usually dropped for mercury barometer calculations unless high precision or a twist is needed.

Assumptions and Scope:

- **Vacuum above column:** The derivation assumes the space above the mercury is vacuum (or at least no air). This is true if the barometer is properly constructed (no leaks). Thus, pressure at the top of the column is just P_v of mercury (nearly zero). If the top wasn't vacuum (say the tube wasn't long enough and air remained inside), it wouldn't be a functioning barometer since that trapped air would exert its own pressure.
- **Static fluid column:** The mercury (or fluid) is static and uniform density. There's no motion, and temperature is relatively uniform (density constant).
- **Atmospheric pressure acts only on the reservoir side:** We assume the top of the column isn't open (it's closed with vacuum above, so only the reservoir side is exposed to Patm). Thus, Patm pushes up the column. Also, we assume one side of the fluid column is effectively at atmospheric pressure (the open reservoir) and the other at P_v (top of tube). So it's like a manometer where one side is Patm and the other is vacuum.
- **Height measured correctly:** We assume the measurement of h is vertical height difference between the fluid level in the reservoir (which is at Patm) and the top of fluid in the tube. In mercury barometers, the reservoir is usually large so its level change is negligible; if not, technically one should account for the fact that the reservoir level drops slightly when mercury rises in the tube (but that's a small geometry detail not needed in typical problems).

Limit Tests (Sanity Checks):

- If $h = 0$, then $P_{\text{atm}} = P_v$. That would mean no column is supported, which would imply atmospheric pressure equals the vapor pressure of the fluid. For mercury, that would basically mean near-zero atmospheric pressure (e.g., if you were in a near vacuum, the mercury would just drain out). That's consistent: if Patm is extremely low (like high altitude or a vacuum chamber), the barometer column falls.
- If P_{atm} increases, h increases linearly. That's intuitive: a higher atmospheric pressure can hold up a taller column. Typically, a change of 1 kPa corresponds to about 7.5 mmHg change (since 101.3 kPa is 760 mm). So if weather pressure goes from 101 kPa to 100 kPa, you'd see maybe ~7.5 mm drop in the column. If you computed something wildly off that scale (like 100 kPa giving 100 mm column—way off), you know there's an error.
- If we switched fluids: say we used water instead of mercury and kept the tube tall enough, at 1 atm (101.3 kPa) the formula $h = P/\rho\, g$ gives $h \approx 10.3$ m. This checks with known fact ~33.9 ft. If we got, say, 1 m using water for 1 atm, that's a sign we used mercury's density by mistake or something. So cross-check: Mercury's huge density is what gives a short column.
- At very high altitude, Patm might be, for example, 50 kPa. Then predicted mercury height $h = 50{,}000/(13550 * 9.81) \approx 0.375$ m (375 mm). If a problem gave something like that scenario, you can verify if it's in plausible range (which it is: roughly half an atmosphere yields roughly half the height ~380 mm).

Use vs. Sibling Equations: Use the barometer relation whenever you need to convert a measurement of column height into an actual pressure, or vice versa, for atmospheric pressure specifically or similar setups. It's effectively a direct application of $p = \rho\, g\, h$. It is a sibling to the manometer equation – indeed, just consider $p_{\text{atm}} - p_{\text{vacuum}} = \rho\, g\, h$. Do not confuse barometric pressure with gauge pressure. If a problem gives atmospheric pressure as "760 mmHg," that is an absolute pressure measurement. If they give a reading from a pressure gauge (not a barometer), that might be gauge unless specified. Another related concept is **vacuum pressure**: sometimes expressed in "mmHg vacuum" meaning how much below atmospheric something is. For example, "a condenser operates at 100 mmHg vacuum" means its pressure is Patm - (100 mmHg), i.e., it's 660 mmHg absolute if Patm is 760. Just keep track: barometer reading is a direct measure of absolute Patm. If you need gauge pressures in problems, often you subtract Patm (which might come from a barometer reading given in the problem).

Common Exam Traps:

- **Unit conversion mix-ups (mmHg to Pa):** Students often know 760 mmHg = 101325 Pa, but when given a different mmHg, they might mess up the direct proportion. A straightforward way: use the ratio or convert explicitly. For example, if Patm = 750 mmHg, you can do $(750/760) \times 101325$ Pa. Or convert mm to m and do $\rho\, g\, h$. A trap is forgetting to convert mm to m: plugging 750 mm as 750 in $\rho\, g\, h$ with SI units will give a result 1000 times too high (because 750 mm is 0.750 m, not 750 m!). So always convert: mm → m. Similarly with inches of mercury: 1 in Hg = 3386.4 Pa (approx). If a pressure is given as 29.0 inHg (a typical barometric reading), convert to Pa by multiplying 29.0 * 3386.4 = ~98205 Pa.
- **Assuming 1 atm exactly equals 101.3 kPa or 14.7 psi in all cases:** That's a standard reference, but if the problem states a slightly different atmospheric pressure (like 100 kPa or 15 psi or 30 inHg, etc.), use the given value. Don't automatically use 101.3 if they gave you a specific barometric reading. Sometimes exam problems set Patm = 100 kPa for simplicity; go with that if stated.
- **Ignoring vapor pressure when it's mentioned:** Occasionally, a problem might be tricky and mention something like "a barometer uses water at 40°C" – at 40°C water's vapor pressure is not negligible (~7.4 kPa). If you ignored that, your pressure calculation would be off. The equation given includes P_v for completeness. If such a case arises, you'd do $P_{\text{atm}} = \rho\, g\, h + P_{v,\text{water@40°C}}$. But unless prompted, you typically assume a mercury barometer or standard conditions where P_v is negligible.
- **Mixing up which fluid's density to use:** This is usually straightforward – it's the barometer fluid's density. But imagine a twist: a barometer filled with some other fluid or maybe a two-fluid barometer (not common, but just in

case). Use the fluid that forms the column. If it's mercury in a tube with some water above it (strange scenario), likely you'd focus on the mercury part if that's what spans between vacuum and interface. Just read carefully which column height is measured and of what fluid.

- **Mistaking a barometer for a closed tank reading:** If a problem describes something like "there's a 5 cm column of oil in a tube connected to a tank," that's not a barometer measuring Patm, that's a manometer scenario. Barometers typically involve one side vacuum. So ensure you identify correctly whether it's a barometer (one side vacuum) or a manometer (both sides fluid/pressure).

Exam Handbook Search Cues (Not affiliated with or endorsed by NCEES): *barometer; atmospheric pressure; mmHg; standard atmosphere* (These will point you to sections on atmospheric pressure and barometric equations in the reference.)

Footnotes:

- **Standard conditions:** The 760 mmHg = 101.325 kPa is defined at 0°C for mercury. If temperature differs, mercury density changes a bit. FE problems usually don't require accounting for that nuance unless they explicitly mention it. Also, standard atmospheric pressure is sometimes given as 14.696 psi (the more exact), but using 14.7 psi is fine. 1 atm is also 29.92 inHg. These equivalences are often listed in unit conversion tables. They might save you time if you recall them. For instance, 1 psi = 2.036 inHg, or 1 inHg ≈ 0.491 psi.
- **Barometer vs. Altitude:** A fun fact (likely beyond exam scope) is that you can estimate altitude from barometric pressure. High altitude = low Patm. While you won't need to compute that on the FE (there's a specific formula for atmospheric pressure vs. altitude, but that's more for other disciplines), just keep in mind atmospheric pressure can vary from ~101 kPa at sea level to ~89 kPa at 1000 m elevation, etc. If a problem gives Patm significantly different from 101 kPa, maybe it's implicitly at altitude or a non-standard day. Use what they give.
- **Applications:** Barometers are not just lab instruments; the concept is used in measuring vacuum pressure in systems (often we say "inches of Hg vacuum"). Also, older aircraft altimeters essentially are aneroids calibrated to barometric pressure. But in an engineering context, you might need the barometric pressure to calculate say the absolute pressure in a tank (if you have a gauge reading and need to add Patm). The barometer provides that Patm.

Variations and Related Forms: While mercury barometers are the classic, there are also **aneroid barometers** (mechanical devices) but those wouldn't be part of a fluid statics calculation – they don't use fluids. However, any time you see pressure given in terms of a fluid height, it's the same principle. For instance, "cm of mercury" or "cm of water" are common. 1 cm of water = 98.1 Pa. 1 mmHg = 133.3 Pa. Also note, **hydrostatic paradox** demonstration: If you had a tall skinny tube vs a wide tank, the height of fluid is what matters, which is exactly barometer logic – even a skinny column of mercury can support atmosphere. In extreme cases, if you had a really light fluid, the barometer would need to be extremely tall (like the water example). So design of barometers depends on fluid choice. The FE won't ask you to design one, but might ask conceptual questions like "Why mercury is used instead of water in a barometer?" (Answer: Because mercury's high density allows a conveniently short column for 1 atm, whereas water would require ~34 ft height).

Special Notes (Calculator Tips): Conversion tasks are typical: e.g., "Convert 750 mm Hg to psi." You can do that in steps: mmHg -> Pa -> psi. Or use ratios: $\frac{750}{760} \times 14.7 \text{ psi} = 14.51 \text{ psi}$ approximately. The exam reference likely provides conversion factors like 1 atm in various units, so you can either recall or quickly look up those. If computing via $\rho\, g\, h$, ensure you plug in correctly. For example, $h = 750 \text{ mm} = 0.750 \text{ m}$, $\rho = 13550$, $g = 9.81$. A quick calculation: $135509.810.750 = 99{,}780$ Pa (which is 99.8 kPa). That's slightly less than 101.3 kPa, as expected for 750 vs 760 mm. Then convert Pa to desired unit if needed (divide by 6894.8 to get psi, for instance). All allowed calculators can handle that easily; just be cautious with scientific notation if using a large number for ρ ($1.355 * 10^4 * 9.81 * 0.75 = \sim 9.978 * 10^4$ in Pa).

Explanation & Analysis (Step-by-Step): The barometer is conceptually simple: it's a balance between atmospheric pressure and the weight of a fluid column. Picture a mercury barometer: The tube was filled and inverted, so initially the mercury wanted to fall due to gravity, but as it falls it creates a vacuum above it. It will stop falling when the pressure exerted by that mercury column equals the pressure of the air pushing up on the outside reservoir. At equilibrium, pressure at the base of the mercury column (just inside the tube, at the same level as the reservoir surface) must equal atmospheric pressure (since the reservoir is open to air). Now, the pressure at that same point inside the tube is due to the column of mercury above: $p = \rho\, g\, h + p_{\text{top of column}}$. The top of the column is near vacuum, so $p_{\text{top}} \approx 0$. Thus $p_{\text{base}} = \rho\, g\, h$. Setting that equal to p_{atm} (which is pushing on the mercury in the reservoir at that same level), we get $p_{\text{atm}} = \rho\, g\, h$. It's basically the hydrostatic formula again. Numerically, if $h = 0.760$ m and mercury density ~13550 kg/m³, then $p_{\text{atm}} = 135509.810.760 \approx 1.01 \times 10^5$ Pa $= 101$ kPa. This matches known atmospheric pressure. If the weather changes or you go up a mountain, Patm drops, so the column height h drops accordingly (less pressure to hold it up). Conversely, in a high-pressure weather system, h might rise a bit. For exam purposes, the key use of this analysis is converting units or understanding gauge vs absolute. For instance, suppose a problem says: "A vacuum chamber is measured at 20 kPa (absolute). If a barometer reads 750 mmHg, what is the gauge pressure in the chamber (relative to atmosphere) in kPa?" Here you'd realize atmospheric is 99.8 kPa (from 750 mmHg as calculated earlier). The chamber absolute is 20 kPa, so gauge (vacuum gauge) = 20 - 99.8 = -79.8 kPa (meaning 79.8 kPa below atmosphere). Or they might give barometric pressure and a gauge reading and want absolute. Always identify Patm from barometer first. Term by term in the equation: $\rho\, g\, h$ is the weight per area of the column of fluid. P_v if included just adds a tiny bit (like if fluid has vapor pressure). For mercury we ignore P_v usually. The beautiful thing about a barometer is it directly visualizes a large pressure (atmospheric) as a moderate length. It is literally the physical representation of 101 kPa as 0.76 m of mercury. When solving problems, just apply $\rho\, g\, h$ carefully and you'll be fine. And remember: when we say "mmHg" as a pressure unit, we're implicitly using this equation. 1 mmHg *is* a unit of pressure defined by that equation (133.3 Pa). So converting between "mm of this fluid" and actual pressures is always a hydrostatic calculation.

K10.T02.S04 – Hydrostatic Forces on Plane Surfaces

Principle Introduction – Force on Submerged Plane & Center of Pressure: When you have a flat surface (plane) submerged in a fluid (for example, a dam gate, a wall of a tank, or a rectangular plate under water), the fluid exerts pressure on every point of that

surface. Because pressure increases with depth, the pressure is not uniform over the surface – it's larger at deeper parts. If you want the total force on that surface, you could imagine integrating pressure over the area. The results of that integration for a plane surface give two important outcomes: (1) the **resultant force $\boldsymbol{F_R}$** (the sum of all the little pressure forces), and (2) the **center of pressure** where that resultant force effectively acts (which is generally below the geometric centroid due to increasing pressure with depth). Key intuitive points:

- **Resultant Force = "average pressure" × area:** For a plane surface in a uniform gravity field, the pressure distribution is linear. It turns out that the *average* pressure on the surface (in the sense of the mean of the pressure over the area) occurs at the centroid of the area (if measured in terms of gauge pressure from the free surface). Thus, the total force can be computed as if that average pressure (which is pressure at centroid) acts on every unit area. In short, $F_R = p(\text{atcentroid}) \times A$. This greatly simplifies problems – you don't need to do complicated integrals on the exam; just find the pressure at the centroid.
- **Center of Pressure is deeper than centroid:** Since pressure increases with depth, there's more force on the lower parts of the surface than on the upper parts. This means the resultant force's line of action will be closer to the bottom than the centroid. The center of pressure is the point where if you assumed the total force F_R acts at that location (a single equivalent force), it would produce the same moment as the distributed pressure actually does. For a vertically oriented plane, this often ends up below the centroid (towards the deeper end). For example, a fully submerged vertical rectangular gate: the centroid is at mid-height, but the center of pressure will be at 2/3 the depth from the surface (for a gate that extends to the surface).
- **Importance of center of pressure:** Engineers need to know this to design hinges and supports – if you only compute the magnitude of force but not where it acts, you can't correctly determine the moment or torque on the gate. On the FE exam, you might be asked for the magnitude of hydrostatic force, the location of that force, or both.
- **Submerged vs partly submerged:** If the surface extends up to the free surface, the pressure at the top edge is zero (gauge), and distribution is triangular from zero to max at bottom. If the surface is entirely below the surface (like a gate that doesn't reach the top of the fluid), then the pressure distribution is a trapezoid (not starting at zero). The formula for force still works with pressure at centroid (which in that case is not just $\rho\ g\ h_C$ unless you measure h_C from the free surface). It's safer to always measure depths from the free surface to wherever you need.
- **Orientation (inclined surfaces):** The same concepts apply if the surface is inclined at some angle. The "depth" should be taken vertically. Often, formulas use the vertical depth of the centroid. If a plate is inclined, its centroid might be at some slant distance from the surface, but the vertical component of that distance is what matters for hydrostatic pressure calculation. So one must be careful to use vertical depth in $\rho\ g\ h$. The area, however, is the actual area of the surface regardless of orientation, and I_{xC} (area moment of inertia about horizontal centroidal axis) should correspond to the shape in its plane. For inclined plates, the FE Handbook typically gives the center-of-pressure location using distances measured along the plate (y); if you convert to vertical depth ($h\ =\ y\ sin\theta$), the center-of-pressure correction term introduces a $\sin^2\theta$ factor (see the equations below).

Equation Passport – Resultant Hydrostatic Force and Center of Pressure – computes the total force on a submerged plane surface due to fluid pressure and the location where this force acts:

For a plane surface of area A with its centroid at vertical depth h_C below the fluid free surface, the resultant fluid force is:

$$F_R = p_C A = (p_0 + \rho g h_C)A$$

And the depth of the center of pressure below the free surface is:

$$h_{CP}\ =\ h_C\ +\ \frac{I_{xC}}{h_C\ A},$$

where I_{xC} is the second moment of area (area moment of inertia) of the surface about a horizontal axis through its centroid (parallel to the free surface).

- $\boldsymbol{F_R}$ – Resultant hydrostatic force on the surface (N). This is the single equivalent force that represents the distributed pressure force. In computing this, $p_C\ A$ already accounts for fluid pressure (including atmospheric if any) across the whole area. Typically, we use *gauge pressure* at centroid for p_C when interested in net force by the fluid (because if both sides of the plate have Patm, those cancel out). If one side of the surface is open to atmosphere and the other side has fluid, using $p_C\ =\ \rho\ g\ h_C$ (gauge) will directly give the net force by fluid on that one side.
- $\boldsymbol{p_C}$ – Pressure at the centroid of the surface (Pa). If the free surface above the plate is open to atmosphere, and h_C is measured from that free surface (with $p_0\ =$ Patm at surface), then $p_C\ =\ Patm\ +\ \rho\ g\ h_C$. For gauge calculations, we'd take $p_0\ =\ 0$ at surface, so $p_C(gauge) = \rho g h_C$. For example, a flat gate fully underwater: find the depth to the centroid, compute pressure there, multiply by area. That gives total force.
- $\boldsymbol{A}$ – Area of the submerged surface (m²). Only the part that is actually in contact with the fluid counts. If the surface is partially above water, only use the submerged portion. A is the actual area of that portion (for instance, width × height for a rectangle submerged).
- $\boldsymbol{h_C}$ – Vertical depth of the area's centroid below the free surface (m). This is crucial: it must be the vertical distance (not along the plane if it's inclined). If the surface is inclined, often they'll give the depth of the top and bottom; you can find the centroid depth as the average of those if it's uniform. If the plate is at an angle, $h_C\ =\ y_C\ \sin\theta$ in the handbook's notation, where y_C is the slant distance along the plate from the surface. Using vertical depth directly simplifies the formula.
- $\boldsymbol{h_{CP}}$ – Vertical depth of the center of pressure below the free surface (m). This tells us where the resultant force acts, measured vertically down from the fluid surface. If the plate is vertical, you could also express it as a distance from the top of the plate, but using absolute depth from surface is unambiguous and aligns with h_C.
- $\boldsymbol{I_{xC}}$ – Second moment of area of the surface about a horizontal axis through the centroid (m⁴). "Horizontal

axis through the centroid" means an axis parallel to the free surface, cutting through the centroid of the shape. This I_{xC} is a geometric property of the shape (like $bh^3/12$ for a rectangle of width b and height h oriented horizontally). It quantifies how area is distributed about that centroidal line. For example, for a rectangle of height H (vertical dimension) and width B (horizontal dimension), with the horizontal axis through centroid (so halfway up the rectangle), $I_{xC} = \frac{B\,H^3}{12}$. This will be needed to find h_{CP}. If the surface is circular, $I_{xC} = \frac{\pi\,D^4}{64}$ with diameter D, etc. It should be provided or easy to compute for common shapes if needed.

- $\boldsymbol{p}_0$ – Pressure at the free surface (Pa). Often this is atmospheric. We include it in the formula $p_0 + \rho\,g\,h_C$ to be general, but in many practical cases p_0 is atmospheric which cancels out if the back of the plate is also at atmospheric. If both sides of the plate have atmospheric pressure, it contributes no net force (Patm on front and back cancel). So effectively many problems use gauge pressure (setting $p_0 = 0$).

Assumptions and Scope:

- **Planar surface:** The formulas here assume a flat surface. For curved surfaces (like a dome or curve of a dam), the force calculation would have to be broken into horizontal and vertical components or integrals; that's beyond the typical FE exam requirement (which usually sticks to flat surfaces or very straightforward curved cases). So ensure you apply this only to plane areas.
- **Incompressible fluid, hydrostatic distribution:** We assume standard hydrostatic conditions (no flow, constant density, pressure varies linearly with depth). So no large depth such that ρ changes significantly, etc.
- **Small surface extent relative to depth changes:** This is usually fine, but implicitly the formula comes from integrating $\rho\,g\,y$ over area. If g changed with depth (like extremely tall columns, or varying gravity), or density varied, you'd need modifications. Not in FE exam scope.
- **One fluid side:** Usually we assume one side of the surface has the fluid and the other side is either air or vacuum or something with negligible pressure, OR if the other side also has fluid, we consider net force. If the problem involves fluid on both sides of the plate (like a gate separating two liquids or water on one side, oil on the other), you can calculate force from each side and then subtract to get net force (effectively using difference in pressure distributions). But the formula $F_R = \rho\,g\,h_C\,A$ can be applied separately for each side's fluid (with their own ρ, h_C relative to their fluid surface). The net force is difference of those if opposite directions.
- **Pressure at centroid usage:** The derivation assumes linear pressure variation. For a plane in uniform gravity field, that holds. If somehow pressure variation wasn't linear (not likely in a static fluid problem unless weird acceleration), then $p_C\,A$ wouldn't be exact average. But in normal hydrostatics, it is.

Limit Tests (Sanity Checks):

- If the fluid had no density ($\rho = 0$ or effectively no fluid), then obviously $F_R = 0$ – nothing pushing, which fits since $\rho\,g\,h_C$ would be zero.
- If the surface area A is zero (no area), $F_R = 0$ – trivial but consistency check.
- If the entire surface is at the same depth (like a horizontal plate of area A located at depth H), then $h_C = H$ and indeed $F_R = \rho\,g\,H\,A$. That's just pressure $p = \rho\,g\,H$ times area, which is correct for uniform pressure on a horizontal plate. And h_{CP} for a horizontal plate isn't really applicable in the same sense (the force is distributed uniformly, any point could be "center" – typically we'd say CP is at centroid trivially because distribution uniform). Our formula $h_{CP} = h_C + I/(h_C A)$ in that case would yield $I = 0$ for an infinitesimally thin horizontal plate orientation (or undefined scenario), so basically one should recognize horizontal surface has uniform pressure, so CP = centroid. This formula is mainly for vertical/inclined where pressure varies.
- Consider a vertical rectangular plate of height H, extending from the surface (top at $h = 0$) down to $h = H$. Centroid at $H/2$, so $h_C = H/2$. The area $A = B \times H$ (where B is width, horizontal). $I_{xC} = \frac{B\,H^3}{12}$. Now plug in: $h_{CP} = H/2 + \frac{(BH^3/12)}{(H/2)BH}$. Simplify: denominator $(H/2)BH = BH^2/2$. So $\frac{I}{h_C\,A} = \frac{B\,H^3/12}{B\,H^2/2} = \frac{B\,H^3}{12} \cdot \frac{2}{B\,H^2} = \frac{H^3}{12} * \frac{2}{H^2} = \frac{H}{6}$. So $h_{CP} = H/2 + H/6 = 2H/3$. That means the center of pressure is at 2/3 the depth (from surface), which is a well-known result for a triangular pressure distribution. If our formula gave something else, we'd know it's wrong. This matches expected: the resultant of a triangle load is at its centroid, which for a triangle (with base at bottom) is at 2/3 from the tip (the surface in this case). Good sanity check. If you do this on exam, it verifies you remembered the formula correctly.
- If the surface is entirely below the free surface (like top of plate at some $h_{\text{top}} > 0$), the distribution is trapezoidal. The formula still works. Suppose a plate from $h = a$ to $h = b$ (so depth range). Then $h_C = (a + b)/2$. And I_{xC} for that rectangle is still $B\,H^3/12$ with $H = b - a$. If you wanted, you could integrate pressures: $F = \int_a^b \rho g y (B dy)$ to get same result. So it's all consistent.

For an inclined surface, the force still uses vertical centroid depth: $F_R = \rho\,g\,h_C A$. But the center of pressure should be handled using the FE form along the plate: $y_{CP} = y_C + \frac{I_{xC}}{y_C A}$, then convert to vertical depth with $h_{CP} = y_{CP} sin\theta$r equivalently use

$$h_{CP} = h_C + \frac{I_{xC}\sin^2\theta}{h_C\,A}$$

(I_{xC} is taken about the centroidal axis in the plane of the plate that is parallel to the free surface.)

Use vs. Sibling Equations: Use these hydrostatic force formulas for flat surfaces submerged in fluids. They save time compared to integrating pressure over area directly. If you had a **curved surface**, you cannot directly use these formulas for total force and center of pressure, because the force direction varies over the surface. In those cases, one approach is to find horizontal and vertical force components (projected area method for horizontal component equals weight of fluid above, etc.). But for FE Mechanical, curved surface problems are less common; if they appear, they usually require finding just the horizontal force on a curved surface (using the projected vertical plane area approach). If confronted with a

curved surface, one trick is: the horizontal component of force on any surface equals the force on the vertical projection of that surface (because $p \cdot A$ horizontal component depends only on depth distribution horizontally). The vertical component is equal to the weight of the fluid above it when the surface serves as the bottom of a container, and so on. But again, those are advanced. For a flat plate, you're safe with these formulas. Don't confuse center of pressure with center of buoyancy (though conceptually related, CoB is for volume forces). Also, this is distinct from **drag forces** (fluid in motion pushing on objects) – here fluid is static, pressure only. If fluid was flowing, you'd need dynamic analysis (drag coefficients, etc., which is another topic).

Common Exam Traps:

- **Using the wrong moment of inertia or formula for I_{xC}:** Many students forget the formula for area moment of inertia for common shapes. The exam reference likely provides basic ones if needed (and you can derive simple ones quickly). For a rectangle width b, height H (horizontal axis through centroid): $I = bH^3/12$. For a triangle, if you need it, or for a circle, etc. If you plug a wrong number (say use $bH^3/3$ or something by mistake), your h_{CP} will be off. It's an easy point to lose. So memorize or have at hand: rectangle, triangle, circle I values. Alternatively, derive: A rectangle's second moment about base is $bH^3/3$, so about centroid it's $bH^3/3 - bH^3/12 = bH^3/12$ by the parallel axis (or just memorize directly).
- **Mixing up reference for h_{CP}:** Sometimes students compute $I/(h_C A)$ correctly, but then they report that number as the distance **below the centroid** rather than adding it to h_C. Remember, the formula is $h_{CP} = h_C + I/(h_C A)$. That $I/(h_C A)$ is the extra distance below the centroid where the force acts. If you accidentally subtract or if you give the answer as just $I/(h_C A)$ (distance below centroid) without adding to the actual depth of centroid from surface, that's wrong in terms of absolute depth. In many textbook formulas, you'll see it presented exactly like we have. So just stick to it.
- **Forgetting to use vertical depth (if inclined plate):** This bears repeating – if the surface is inclined, h_C must be the vertical depth to centroid, not the length along the surface. If a plate is inclined at angle θ, and you're given that the centroid is, say, 5 m from the hinge along the plate, and the top of the plate is at 2 m depth, you should find the vertical depth of the centroid (which might be, say, 5 m * sinθ from top if top is at 2 m). Many errors occur by just averaging the depth of top and bottom without considering angle – but actually averaging top and bottom depth *does* give the vertical centroid depth directly, so that's fine if you know top and bottom depths. If given the plate length and angle, compute depth for top and bottom then average. Essentially, do everything in terms of vertical distances.
- **Not distinguishing where the force is measured from:** If a question asks "location of center of pressure **from the hinge at the top of the gate**," for example, you might need to report not the absolute depth from the free surface, but the distance along the gate from the top. In that case, if the gate is vertical, it's basically the same as depth minus the top depth. But if the gate is inclined or if they specifically want distance measured along the surface from top, you have to do a bit of geometry. Typically: if the gate is vertical, h_{CP} from surface and the top of gate is at some depth h_{top}, then the distance below the top of gate = $h_{CP} - h_{\text{top}}$. If the gate is inclined, you find h_{CP} vertical, but then dividing by $\sin\theta$ could give you the slant distance from the top if needed. Many slip-ups happen here if one doesn't carefully parse the question wording. Always clarify: are they asking for the depth from fluid surface (which is h_{CP} itself), or the distance measured on the plate from a certain point?
- **Including atmospheric pressure when not needed:** If both sides of the surface have atmospheric pressure, that part cancels out. It's fine to calculate F_R including $p_0 A$ on the front, but realize there's also $p_0 A$ on the back pushing opposite – net cancels. So using gauge pressure (i.e., just $\rho\, g\, h_C$) is typically safer to get net force due to fluid. If a problem specifically had a pressurized gas on the backside, you'd incorporate that difference. But standard cases assume one side fluid, other side air at Patm, so we use gauge (difference) automatically. A trap could be if someone mistakenly multiplies Patm by area and thinks it's additional force if not recognizing it's on both sides. (One exception: if the problem specifically asks total force including atmospheric, maybe for a cover or something where backside is vacuum, then yes include it. But they'll make that clear.)

Exam Handbook Search Cues (Not affiliated with or endorsed by NCEES): *submerged plane; hydrostatic force; center of pressure; Ix; centroid* (These keywords will help locate formula summaries for forces on surfaces in the handbook.)

Footnotes:

- The FE Handbook typically gives the center-of-pressure location along the plane: $y_{CP} = y_C + \frac{I_{xC}}{y_C A}$. To express it in vertical depth, use $h_C = y_C \sin\theta$ and $h_{CP} = y_{CP} \sin\theta$ which gives: $h_{CP} = h_C + \frac{I_{xC} \sin^2\theta}{h_C A}$. For a vertical plate ($\theta = 90°$, $\sin\theta = 1$), this reduces to $h_{CP} = h_C + \frac{I_{xC}}{h_C A}$.
- If the surface is composite or irregular, you might need to compute h_C and I_{xC} piecewise or with known formulas. Usually FE problems keep it simple: rectangles, triangles, circles. For a triangle (like a triangular gate), the centroid depth is easy (e.g., one-third from base if base is at surface or something) and I_{xC} can be found or is given. Don't panic, they usually either give I or shape is simple enough to know.
- If fluid is on both sides: e.g., a gate holding water on one side and oil on the other, you can compute F_{water} and F_{oil} and find their respective h_{CP} from each side, then find the net force and possibly net moment. A quick way: find net pressure at each depth = $\rho_{\text{water}}\, g\, h - \rho_{\text{oil}}\, g\, h$ (assuming same g and measuring h from respective free surfaces aligned at same level for simplicity, or if surfaces at different heights, a bit more complex). The net pressure distribution might still be linear if both fluids are uniform. You could treat it as one fluid of density $(\rho_{water} - \rho_{oil})$ effectively if one surface is open to the other fluid's surface. This is advanced, but in principle if needed you can do that. Usually not needed unless a question specifically gives that scenario (rare for FE).
- **Moments and forces on supports:** The center of pressure allows you to compute the moment about a reference. For example, if a gate is hinged at the top, you can take the force F_R acting at h_{CP} (measured from the

surface) and find the moment about the hinge. That's F_R times the horizontal distance from hinge (if hinge at top of plate, you use vertical distance if plate is vertical, which is basically difference between h_{CP} and hinge depth). The exam might ask for that moment or the force on a hinge, etc. So conceptually, once you have F_R and h_{CP}, you can solve equilibrium. Just be careful: if asked for "force at hinge," that usually involves splitting weight vs fluid, but if it's just a hydro question, likely they want either the moment or the reaction given just hydro force.

Variations and Related Forms: If the surface is not fully submerged (e.g., top is above water), then only consider the submerged portion for area, centroid, etc. If it's a weird shape, consider breaking it into simpler shapes (though unlikely needed in exam context). For **dam problems** or **retaining walls** in civil, the same idea is used (triangular pressure distribution of water). For example, water against a wall: $F_R = \frac{1}{2}\gamma H^2 \times 1$ (per unit width) and acts at $H/3$ from bottom. That's essentially using these formulas for a triangle distribution (which indeed yields $2H/3$ from surface, i.e., $H/3$ from bottom for total height H). It's consistent. If a question gives you a figure with a gate at some angle, the safest approach is: find h_C (vertical), plug into formula. There is also a formula for **force on a plane surface of arbitrary orientation**: $F_R = \rho\, g\, A\, h_C$ (with h_C measured vertically), which shows orientation doesn't change magnitude of force – interesting but true (a tilted plate at a given depth experiences the same total force as if it were projected vertically, as long as h_C is same). Orientation only affects the component directions and location along plate. This is a sometimes testable concept: if you have the same gate at an angle or vertical, F_R remains $\rho\, g\, h_C\, A$. So they might ask conceptually "Does the force on a gate change with angle?" Answer: magnitude no (if h_C unchanged), but the line of action relative to the gate might shift because of geometry.
Finally, sometimes instead of giving I_{xC}, they might directly give the formula or numeric result for h_{CP}. If not, you have to compute I_{xC}. Reiterate: memorize I formulas for rectangle and triangle just in case.

Special Notes (Calculator Usage): Calculating F_R is straightforward multiplication. Calculating h_{CP} might involve computing I_{xC}. If you have to calculate I_{xC}, do it carefully: e.g., rectangle $I = bH^3/12$. If H is say 4 m and b 2 m, that's $2(64)/12 = 10.67\ m^4$. Use the calculator carefully for these power operations (most have a x^3 or you just do ^ or multiply out). It's easy to hit a wrong button and square instead of cube. Double-check dimension units: I in m^4 can be a large or small number depending on size. When dividing by h_C A, keep track of each part: $I/(h_C A)$ has units of length (m). It might help to compute $I/(A)$ first (which has units m²) then divide by h_C (m). Some calculators might allow you to do it in one sequence; just avoid mixing up which is in numerator/denominator. If you are uncomfortable, break it into steps on scratch paper: "$I/(A) = \cdots$, then divide by h_C". That reduces error chances. The Casio or TI calculators have no issue with these operations. If a number is large (like I could be, say a large shape), use scientific notation carefully. For instance $I = 1.067 \times 10^1$ (like above 10.67) if it's moderate. If it's e.g. a dam 50 m high with width 10 m, $I = 1050^3/12 = 10 * 125000/12 = 1041666\ m^4$ (1.041e6), that's fine, your calc can handle it. Just be mindful of potentially needing to use exponential notation input if it's bigger.
One more tip: You can sanity-check h_{CP} result by ensuring it's greater than h_C but not beyond the bottom of the plate. If you got an h_{CP} that's above h_C, something went wrong (that would imply negative I or such, impossible). If you got an h_{CP} deeper than the bottom of plate, also wrong (you maybe used wrong h_C or I). So after computing, quickly reflect if it's plausible (should be between h_C and bottom depth for typical cases).

Explanation & Analysis (Step-by-Step): To see why $F_R = p_C A$ and $h_{CP} = h_C + \frac{I}{h_C A}$, consider deriving from basics for a vertical plate first (it generalizes). Take a vertical rectangular gate submerged in water. Divide it into thin horizontal strips of width B and height $\mathrm{d}y$. At depth y below the surface, pressure $p(y) = \rho g y$ (gauge). The force on that strip $\mathrm{d}F = p(y) \times (B\,\mathrm{d}y)$. To get total force, integrate from top $(y = y_{\text{top}})$ to bottom $(y = y_{\text{bot}})$:

$$F_R = \int_{y_{\text{top}}}^{y_{\text{bot}}} \rho g y B\,\mathrm{d}y = \rho g B \left[\frac{y^2}{2}\right]_{y_{\text{top}}}^{y_{\text{bot}}} = \rho g B \frac{y_{\text{bot}}^2 - y_{\text{top}}^2}{2}$$

Now note

$$\frac{y_{\text{bot}}^2 - y_{\text{top}}^2}{2} = \frac{(y_{\text{bot}} + y_{\text{top}})(y_{\text{bot}} - y_{\text{top}})}{2}$$

And $(y_{\text{bot}} - y_{\text{top}})$ is the height H. Also

$$\frac{y_{\text{bot}} + y_{\text{top}}}{2} = \frac{y_{\text{top}} + (y_{\text{top}} + H)}{2} = y_{\text{top}} + \frac{H}{2} = h_C$$

(depth to centroid). So it becomes $\rho g B H h_C$. But $BH = A$. So indeed $F_R = \rho g h_C A = p_C A$ (since $p_C = \rho g h_C$ for gauge). That's the magnitude. For center of pressure: we want the moment of this force about the free surface (or any reference). The actual distributed force has a moment about the surface

$$M = \int y\,\mathrm{d}F$$
$$= \int_{y_{\text{top}}}^{y_{\text{bot}}} y\,\rho g y B\,\mathrm{d}y = \rho g B \int_{y_{\text{top}}}^{y_{\text{bot}}} y^2\,\mathrm{d}y$$
$$= \rho g B \left[\frac{y^3}{3}\right]_{y_{\text{top}}}^{y_{\text{bot}}} = \rho g B \frac{y_{\text{bot}}^3 - y_{\text{top}}^3}{3}$$

On the other hand, if we pretend the resultant F_R acts at depth h_{CP}, the moment would be $F_R \cdot h_{CP}$. Setting the distributed moment equal to $F_R h_{CP}$:

$$\rho g B \frac{y_{\text{bot}}^3 - y_{\text{top}}^3}{3} = (\rho g h_C B H)(h_{CP})$$

Simplify left:

$$\frac{y_{\text{bot}}^3 - y_{\text{top}}^3}{3} = \frac{(y_{\text{bot}} - y_{\text{top}})(y_{\text{bot}}^2 + y_{\text{bot}} y_{\text{top}} + y_{\text{top}}^2)}{3}$$
$$= \frac{H\,(y_{\text{bot}}^2 + y_{\text{bot}} y_{\text{top}} + y_{\text{top}}^2)}{3}$$

Meanwhile $h_C = (y_{\text{bot}} + y_{\text{top}})/2$ and $H = y_{\text{bot}} - y_{\text{top}}$. After some algebra, h_{CP} comes out to $h_{CP} = h_C + \frac{(y_{\text{bot}} - y_{\text{top}})^2}{12\,h_C}$ (trusting the

known result), which indeed equals $h_{CP} = h_C + \frac{H^2}{12\,h_C}$. Now note I_{xC} for a rectangle about its centroid: $I_{xC} = \frac{BH^3}{12}$. Divide that by BH (which is A) and by h_C appropriately, you end up with the same expression $\frac{H^2}{12\,h_C}$. So $h_{CP} = h_C + \frac{I_{xC}}{h_C A}$. This derivation confirms it. In simpler terms: the extra term $\frac{I}{h_C A}$ is like a correction that accounts for the second moment (how the pressure "distribution area" is spread). If I is large (meaning the shape is tall, area far from centroid), then the center of pressure shift is larger. If the shape is small or pressure nearly uniform (I small, or h_C large relative to shape), then $h_{CP} \approx h_C$ (center of pressure near centroid). For example, if the plate were very small compared to its depth (like a small window deep underwater), pressure is almost uniform on it, so CP ~centroid. Conversely, a tall gate from surface down: I big, CP significantly below centroid. Now, in applying these formulas, the process is: identify h_C (vertical). Compute p_C (if needed absolute or gauge). Then $F_R = p_C A$ (if using absolute pressure including p_{atm}, that gives total force including atmospheric contribution; often we use gauge so that F_R is just from water above p_{atm}). Next find I_{xC} for the shape, plug into h_{CP} formula. Once you have h_{CP}, interpret it per question – e.g., measure from surface or from some point. A quick example: A 2 m high, 3 m wide rectangular gate with top 1 m below water surface. Find the hydrostatic force and where it acts. Here $A = 2 \times 3 = 6\text{m}^2$. The centroid is at $1\text{ m} + 1\text{ m}$ (half of 2) $= 2$ m depth. So $h_C = 2$ m. $\rho g h_C$ (for water) $= 9810 \times 2 = 19620$ Pa gauge at centroid. So $F_R = 19620 \times 6 = 117720$ N (≈ 117.7 kN) pushing on the gate. For center of pressure:

$$I_{xC} = \frac{3(2)^3}{12} = \frac{3 \cdot 8}{12} = 2m^4$$

Now $h_{CP} = 2 + \frac{2}{(2 \cdot 6)} = 2 + \frac{2}{12} = 2 + 0.167 \approx 2.167$ m. That's the depth from surface: ~ 2.17 m below surface. The gate extends from 1 m to 3 m depth (since 1 m top + 2 m height = 3 m bottom), so indeed 2.17 m is within that (it's about 1.17 m below the top of gate). That seems reasonable (a bit below midpoint 2 m). If the gate had extended to surface, we'd have gotten 2.67 m from surface for bottom 3 m, which is $2/3$ of 3. But since here top at 1 m, it shifted accordingly. This matches what we'd expect from the integration or intuitive that distribution is a trapezoid. As a student, doing this step-by-step ensures you apply formulas correctly rather than memorizing blindly. And always double-check units in these calculations. One more thing to analyze: If atmospheric pressure is acting on both sides of the gate, it cancels out in net force. Our calculation used gauge (took 0 at surface). If you had used absolute (101,325 Pa at surface), you'd get a huge number for F_R, but then realize the other side also has that same pressure on the same A, so net would subtract. So gauge is simpler for net force problems.

In summary, the hydrostatic force and center of pressure formulas allow you to handle problems quickly that would otherwise require calculus. They are derived from that calculus, but you just plug values. On the exam, identify the geometry, find area, centroid depth, get F_R, then find I_{xC} and get h_{CP}. It's systematic. With this understanding, you can confidently tackle any submerged surface problem thrown your way.

K10.T02.S05 – Buoyancy (Archimedes' Principle)

Principle Introduction – Buoyant Force on Submerged/Floating Bodies: Archimedes' principle states that an object fully or partly immersed in a fluid is acted on by an upward buoyant force equal to the weight of the fluid displaced by the object. In simpler terms, if you submerge a volume of fluid equal to the volume of the object, how much would that fluid weigh? That is exactly the force pushing the object up. Key points about buoyancy:

- **Pressure difference causes buoyancy:** Fluids exert pressure on all surfaces of a submerged object. The pressure on the bottom of the object is greater than on the top because the bottom is at a deeper level in the fluid. This difference results in a net upward force. Archimedes' principle gives a shortcut to calculate that net force without integrating pressures on each surface: just consider the weight of the displaced fluid.
- **Fully vs partially submerged:** If an object is fully submerged, it displaces a fluid volume equal to its own volume. If it floats or is only partly submerged, it displaces only the amount of fluid corresponding to the portion of the object that is underwater. In either case, *buoyant force = weight of displaced fluid*. For a floating object, by definition, it displaces just enough fluid so that buoyant force equals its weight (that's why it floats at a certain fraction submerged).
- **Direction of buoyant force:** Buoyant force always acts upward (opposite to gravity) – it's what makes things float or feel lighter in water. It acts through the **center of buoyancy**, which is the geometric centroid of the fluid volume displaced by the object's submerged part. For homogeneous fluids, that's just the centroid of the object's submerged volume. For symmetrical objects, the center of buoyancy often aligns with the object's geometric center when fully submerged. If floating, the center of buoyancy can shift as it tilts, which is related to stability (metacenter concept), but that's beyond FE scope except maybe conceptually.
- **Density comparison (sink or float):** What happens to an object in a fluid depends on density: if the object's average density is higher than the fluid's, it will sink (because its weight exceeds the buoyant force for that volume). If it's less, it will float (it only needs to submerge until buoyant force equals weight, which will happen before full submersion). If equal, it will neutrally buoyant (hover anywhere in fluid). So an easy test: Specific Gravity (SG) of object vs fluid. If $SG_{obj} > SG_{fluid}$, sink; if <, float; if equal, neutrally buoyant.
- **Archimedes' principle applies to any fluid:** Not just liquids, also gases. For example, helium balloons float in air because helium+balloon has lower weight than the air displaced. But in FE Mechanical, most buoyancy questions are about solids in liquids (water usually).

Equation Passport – Buoyant Force (Archimedes' Principle) – calculates the upward force exerted by a fluid on a submerged or floating body:

$$F_B = \rho_f\, g\, V_d$$

- $\boldsymbol{F_B}$ – Buoyant force (N). This is the net upward force the fluid exerts on the object. It effectively reduces the apparent weight of the object when submerged (apparent weight = actual weight $- F_B$ if object is fully submerged and not accelerating). If the object is floating, F_B equals the object's weight (in equilibrium).
- $\boldsymbol{\rho_f}$ – Density of the fluid (kg/m³) *in which the object is submerged*. It is **not** the density of the object (unless the problem manipulates the formula differently). Use the

fluid's density, because it's the fluid's weight you're calculating. For water, $\rho \approx 1000\ \mathrm{kg/m^3}$. If it's seawater, maybe 1025 kg/m³, etc. If it's mercury or oil or any fluid, use the given or known density.

- $\boldsymbol{g}$ – Acceleration due to gravity (m/s²). Standard 9.81 m/s².
- $\boldsymbol{V_d}$ – Volume of fluid displaced (m³). This is the volume of fluid that's been "pushed out of the way" by the object. If the object is fully submerged, V_d is simply the volume of the object (the portion underwater). If partially submerged, it's the volume of the part that's underwater. For a floating object, you may need to calculate what fraction of the volume is submerged by equating F_B to weight. For a fully submerged object, you often get V_d from dimensions given or via weight difference, etc.

Assumptions and Scope:

- **Fluid statics conditions:** The object is either static or moving slowly without significant fluid dynamics effects (no drag or lift from motion – just buoyancy). No waves or splashing; just a calm fluid.
- **Uniform fluid density:** We assume the fluid's density is uniform throughout the volume displaced (valid for liquids or well-mixed fluids). If the fluid density varies with depth (like in atmosphere or thermocline in ocean), Archimedes' principle still conceptually holds but ρ might need to be considered as some average or integrated. FE problems usually have constant ρ.
- **Object size not too large compared to fluid container:** Usually we assume there's plenty of fluid around so that fluid can be displaced freely (no significant change in fluid level or container effects unless specifically part of problem). But even if container small, principle still works; just sometimes you could consider rising fluid level if needed. Typically not needed unless a volume is given to find rise in water level, etc.
- **No other forces except gravity and buoyancy considered:** We neglect surface tension (for large objects that's fine), and we assume no adhesion or other sticking forces. Also assume object is fully submerged or floating stably, not held by strings unless included in problem (if there is a string or support, tension will come into play but buoyancy still same).
- **Static equilibrium if floating:** If an object floats, it's in static equilibrium (vertical forces balance: $F_B = W_{\text{object}}$). If it's just submerged and you're holding it, the buoyant force still is there, but net force might not be zero (object might be heavy and you might be providing additional force to hold it). But the formula for F_B doesn't depend on what the object is or how heavy; it's purely fluid and volume.

Limit Tests (Sanity Checks):

- If $\rho_f = 0$ (imagine no fluid, like vacuum), then $F_B = 0$. Indeed, in a vacuum nothing floats by buoyancy (a helium balloon won't float without air density).
- If $V_d = 0$ (object not submerged at all), $F_B = 0$. Makes sense: if an object isn't in the fluid, fluid can't push on it (aside from maybe some slight atmospheric buoyancy, but if it's not displacing fluid, no buoyant force).
- If the object is fully submerged in water with volume 1 m³, then $F_B = 1000 * 9.81 * 1 = 9810\,N \approx 10\,kN$. That's the weight of 1000 kg of water, which is about 2200 lbf. So a 1 m³ block gets a buoyant force of ~10 kN upward. If the block weighs more than 10 kN (mass >1000 kg), it'll sink (because weight down > buoyant up). If less, it'll float upward. If exactly equal, it'll just hang neutrally.
- Consider an object's density vs fluid: If object's density ρ_o equals ρ_f, then F_B at full submersion would equal object's weight (because $m_o\, g = \rho_o\, V\, g$, and $F_B = \rho_f\, V\, g$, if $\rho_o = \rho_f$, then $F_B = m_o\, g$). So neutrally buoyant. If ρ_o is double ρ_f, then at full submersion F_B is half of its weight – meaning it'd still sink (with net downward force equal to difference). If ρ_o is half of ρ_f, then even half-submerged object will have enough buoyant force to equal its weight (that's exactly how far it'll float: 50% submerged yields equilibrium).
- For a floating scenario: say a wooden block of volume 0.2 m³ and density 600 kg/m³ in water. Its weight $W = 6000.29.81 = 1177.2\,N$. It will float until $F_B = W$. Now $F_B = 10009.81\,V_d$. Set $10009.81 V_d = 1177.2$, solve $V_d = 1177.2/(9810) = 0.12$ m³. So out of 0.2 m³, it needs to displace 0.12 m³. That means 60% of it is submerged (0.12/0.2 = 0.6) and 40% above water. This fraction equals the ratio of object density to fluid density (600/1000 = 0.6). This is a general result: fraction submerged = $\rho_{\text{object}}/\rho_{\text{fluid}}$. That's a good check or quick ratio to know.
- If you mistakenly used the object's density in the formula instead of fluid's, you'd get $F_B = \rho_{\text{object}}\, g\, V$ which is just weight of object. That only equals F_B in neutral cases; otherwise it's not correct. So ensure correct ρ.

Use vs. Sibling Equations: This buoyancy formula is straightforward and unique to static fluids. Use it whenever you need the buoyant force. Do **not** confuse buoyant force with drag force (drag occurs when object moves through fluid). Also, don't confuse with the hydrostatic force on surfaces (like on walls) – buoyancy is about a fully or partially submerged **body** and is equivalent to considering all pressure forces on its surface. If you actually integrated pressure over the entire surface of a submerged object, the horizontal components cancel out (symmetrically) and the vertical components sum to $\rho\, g\, V_d$ upward. That's how Archimedes principle comes out of integration. There's also a formula for the buoyant force in terms of weight of displaced fluid: $F_B = W_{\text{fluid,disp}}$. In US units, sometimes easier to compute in weight form: e.g., displaced volume (ft³) * γ (lbf/ft³) = buoyant force in lbf. Use which is convenient. Another related concept: **apparent weight** of an object in fluid = actual weight - buoyant force. They might ask something like "What is the tension in a string holding a submerged object?" Then you find buoyant force and do $T = W - F_B$ (if at rest). If accelerating, that's beyond statics, but basic static equilibrium covers many cases.

Common Exam Traps:

- **Using wrong density or volume:** As noted, one might plug the object's density accidentally. Always double-check: buoyant force uses fluid density and displaced volume. The object's density usually is used to find how much volume must be submerged for equilibrium, not directly in the buoyant force formula (unless you equate F_B to weight). Similarly, ensure the volume you use is the portion submerged. If they give linear dimensions of an object and say it floats with some portion out, you might

have to deduce V_d carefully. Or if an object is just submerged, V_d is just the object's full volume.

- **Ignoring that object might not be fully submerged:** Some problems might give you the mass and dimensions of an object and ask whether it will float or sink (and if float, how much sticks out). A mistake is to assume fully submerged and calculate F_B and compare to weight after the fact. Instead, you should compare densities first. If $\rho_{\text{object}} < \rho_{\text{fluid}}$, it will not be fully submerged at equilibrium. Trying to use $F_B = \rho_f\, g\, V_{\text{object}}$ (full volume) in that case yields a buoyant force bigger than its weight, implying it accelerates upward out of water until equilibrium at partial submersion. So for a floating object, set $F_B = W$ and solve for submerged volume or fraction. If your computation yields a submerged volume less than object's total, consistent it floats partially. If it needed more volume than available, then it means even fully submerged buoyancy wasn't enough (so it sinks).
- **Confusing weight of displaced fluid with weight of object in calculations:** For example, a question might ask "A 500 kg object is submerged in water. What is the buoyant force on it?" Many might incorrectly start thinking about the 500 kg or weight. But all that matters is volume of object * fluid density. If they gave 500 kg and maybe implied a certain volume via object density, you have to get volume first. Alternatively, one might incorrectly answer "500 kg of force" or something. Instead, find the volume (mass/object density if given) then apply fluid density.
- **Unit mistakes when computing weight of displaced fluid:** If volume is given in liters or cm³, convert to m³. If density in g/cm³, convert to kg/m³ or use consistent. Or if using weight density (like γ in lbf/ft³), ensure volume is in ft³ to get lbf. It's easy to slip e.g., using 1000 kg/m³ and volume in cm³. As a check, buoyant forces in SI typically come out in the range of thousands of Newtons for human-scale volumes (like a 1 liter volume displaces 9.8 N ~ about 2.2 lbf). If you get something like 9800 N for 1 liter, you are off by factor of 1000 (likely used cm³ as m³ or forgot conversion).
- **Forgetting that F_B acts at center of buoyancy (in case of moments):** If a problem involves a submerged object pinned or hinged, you might need to consider where the buoyant force acts to do moment balance. The center of buoyancy lies at the centroid of the displaced fluid volume. For a uniform shape fully submerged, that's just its geometric center. If floating partially, it's the centroid of the underwater shape (which might not coincide with the object's overall centroid if asymmetrically submerged). Usually FE problems avoid stability calcs, but just in case: know that F_B line of action goes through center of buoyancy. If object's center of mass is below center of buoyancy, it's stable; if above, could be unstable (like flipping). But mechanical FE likely won't go deep into stability of floating bodies (that's more naval architecture). They might just test conceptually that center of buoyancy is the centroid of displaced fluid volume.
- **Adding mass of fluid to object's weight or something weird:** Sometimes confusion arises like "the object seems lighter in water by buoyant force." Yes, apparent weight = weight - F_B. People sometimes plug into Newton's law incorrectly. Just remember: If an object of weight 50 N is underwater and experiences 20 N buoyant force up, a scale under it would read 30 N (apparent weight) because 20 N is supported by buoyancy. That's a common style question: "Weight in air vs weight in water." The difference is buoyant force (equal to weight of displaced fluid).

Exam Handbook Search Cues (Not affiliated with or endorsed by NCEES): *buoyant force; Archimedes; displaced volume; specific gravity* (Likely points to Archimedes' principle statement and formulas in the reference.)

Footnotes:

- Archimedes reportedly shouted "Eureka!" after discovering this principle. While that's just a fun anecdote, the principle is fundamental and universally true. It doesn't matter the shape of the object or how deep it is (as long as fully submerged the buoyant force is the same at any depth, which is a little counterintuitive but true; pressure is higher at depth but acts on same volume with more on bottom and also more on top compared to shallow – it cancels out such that F_B only depends on volume * density * g). If the fluid is the same and object fully submerged, F_B doesn't depend on depth – a surprising fact: a submarine experiences the same buoyant force at 5 m as at 50 m if it doesn't compress or change volume, but the pressure differences are larger at 50 m on each part, still net same. However, in reality, compressibility might reduce volume slightly at extreme depth, lowering F_B, but that's beyond ideal assumption.

Specific Gravity (SG): This term might be used. SG is ratio of object's density to water's (for liquids/solids) or to air's (for gases sometimes). If SG < 1, object floats in water. The fraction submerged for a floating object = SG (when referencing water). For example, SG of ice ~0.92, so ~92% of an ice cube's volume is submerged in water (hence 8% above – like icebergs). This is a quick way to do float problems. If SG > 1, the object sinks (e.g., SG of steel ~7.8, way >1, sinks). If a question gives SG, you know relative buoyancy immediately. And F_B = SG * volume * 1000 * g? Actually careful: SG is relative to water. So if an object volume V has SG 0.8, its mass is $0.81000V = 800V$ kg (since $\rho_{\text{obj}} = 0.8 * 1000$). If in water, it will float with 80% submerged, because it needs to displace a volume that weighs as much as itself. Usually straightforward.

If the fluid isn't water, sometimes they give fluid's SG relative to water. Then $\rho_f = \text{SG}_f * 1000$ kg/m³ if water is reference. You can adapt accordingly.

Multiple fluids and buoyancy: If an object straddles two fluids (like floating at interface of oil and water), the buoyant force is sum of forces from each fluid. For example, an object partly in water, partly in air effectively gets most buoyancy from water (air's contribution is tiny usually). Or an object partly in oil on water gets buoyancy from both oil and water in the portions submerged in each. The handbook note states this: if at interface, total buoyant force = weight of fluid1 displaced + weight of fluid2 displaced. So if you ever have that scenario (rare), just do separate volumes in each fluid.

Measuring volume by buoyancy (a common app): If you submerge an object and measure the buoyant force (or apparent weight loss), you can compute its volume. This is how they measure volume/density of irregular objects (like the Archimedes story with the gold crown). E.g., you have an object weight 30 N in

air, 20 N in water, buoyant force = 10 N, which corresponds to ~1.02 kg of water = 0.00102 m³ volume. Then knowing object mass (via weight 30 N = 3.06 kg), you can find density ~3000 kg/m³ (just an aside, how FE might blend a question with density calc).

Variations and Related Forms: In some cases, they might incorporate buoyancy into force balance problems. For example, "what tension is needed to hold a 100 kg object underwater?" Then you do: weight down 981 N, buoyant up $\rho_f\ V\ g$. If volume not given directly, compute from mass and object density or SG. Then tension = weight - buoyant force (assuming downward weight, upward buoyancy, and no acceleration). Another variation: objects attached together (like a buoyant object attached to a heavy object). You then consider combined weight vs combined buoyancy, etc. Or a submerged tank that is bolted down, find the force on bolts due to buoyancy (which would be the buoyant force if empty inside). Because, for example, an empty underwater container (like a submarine full of air) has a strong buoyant force wanting to lift it. They might ask the net upward force on it (which is just F_B minus its weight). If weight is small, net upforce ~ F_B. Actually, if it's bolted, the bolts feel that $F_B\ -\ W$. If $F_B > W$, it tends to rise. If they mention stability of floating objects or "metacenter," that's probably beyond exam requirement, but basic stability: if center of mass is below center of buoyancy, stable (like a buoy with weight at bottom). If above, can tip (like an upside-down boat will flip). But likely not quantitatively asked.

Special Notes (Calculator Tips): Buoyancy calcs are usually pretty straightforward numerically – just multiplication. The potential tricky part is unit conversion for volumes (which is more conceptual than calc difficulty). If you have to find volume from mass and density, do $V\ =\ m/\rho$. That might involve division in calc. Example: 2 kg object, density 500 kg/m³, volume = 2/500 = 0.004 m³. Then buoyant force in water = $10009.810.004\ =\ 39.24\ N$. Many times numbers are nice or simplified. Keep track of whether they want answer in Newtons or perhaps in kgf (though typically they stick to N). If given weights in N, use those directly; if masses in kg, multiply by 9.81 for weight, etc. The allowed calculators can handle these with ease. One slight caution: if doing difference between large numbers (like a heavy object's weight minus buoyancy), do enough significant digits to avoid rounding error. But FE problems usually have a tolerance. For instance, weight = 10000 N, buoyant = 8000 N, net = 2000 N. Just don't accidentally subtract incorrectly or something. A common simple check: F_B in water is roughly $9.8\ *$ mass of displaced water. If an object is lighter than equal volume water, it floats. People sometimes compare directly masses: e.g., object mass 500 kg, water-displaced mass if fully submerged would be volume*1000. If object mass < displaced water mass, it floats (displaces only part of that water mass equal to its own). Use whatever mental approach to verify.

Explanation & Analysis (Step-by-Step): Imagine immersing a solid cube in water. Water exerts pressure on all faces of the cube. The pressure on the bottom face is higher than on the top face (because bottom is deeper). The side forces (left vs right, front vs back) cancel out because pressures at equal depths on opposite sides are equal and areas are equal, just opposite directions. So the net horizontal force is zero. Vertically, there's an upward net force: bottom face has an upward force = pressure at bottom * area of face, top face has a downward force = pressure at top * area. The difference is $(p_{bottom} - p_{top}) * A$. Since $p\ =\ \rho\ g\ h$, $(p_{bottom} - p_{top}) = \rho g(h_{bottom} - h_{top}) = \rho g(\Delta h)$, which is $\rho\ g$ times the cube's height. So $(p_{bottom} - p_{top})A = \rho g(\Delta h)A$. But $\Delta\ h\ *\ A$ is actually the volume of the cube V. So that equals $\rho\ g\ V$. That is F_B. And $\rho\ V$ is the mass of water that would occupy that cube volume; $\rho\ g\ V$ is its weight. That derivation shows Archimedes principle for a rectangular shape; it doesn't depend on shape actually – any shape, the difference in pressure forces up vs down yields $\rho\ g\ V_d$. Archimedes principle tells us we can skip the integration and just do that. Now, if the object is floating, it displaces only part of its volume until $F_B\ =\ W$. Taking a concrete example: a raft weighs 200 N. How much water volume must it displace? Well, water weight per cubic meter is ~9810 N, so it needs to displace $200/9810\ =\ 0.02039$ m³ of water to get 200 N of buoyancy. If the raft's bottom area is known, we could find how submerged depth that is. That's a typical design: e.g., each cubic meter of foam can support ~1000 kg of load (since it can displace 1000 kg of water if fully submerged). So engineers size flotation accordingly. For exam, you might be asked: "A block of SG 0.5 floats in water. What fraction is above water?" Since SG 0.5 means it's half as dense as water, it only needs to displace half of its volume to equal its weight. So 50% submerged, 50% above. Or maybe: "A 5 m³ balloon is filled with helium (density ~0.18 kg/m³). How much lift does it provide in air (density ~1.225 kg/m³)?" Buoyant force = weight of 5 m³ air - weight of 5 m³ helium. That's $(1.225 - 0.18)59.81 = 59.811.045 = 51.2N$ upward net (which can lift ~5.2 kg mass at most minus balloon weight). This shows you could also do difference of densities times volume times g in cases where the object is also a fluid like gas inside balloon. But the safe way: $F_B\ =\ \rho_{air}\ g\ V$, weight of helium = $\rho_{He}\ g\ V$ downward (plus balloon skin weight perhaps), net lift = $F_B\ -\ W_{He}\ -\ W_{balloon}$. But I digress; typically FE mechanical won't go heavy into balloon calcs, but one could appear as concept. If an object is held submerged by a string or needed to find tension, you do equilibrium: tension + buoyancy = weight if at rest (object "feels lighter"). For analysis: each term $\rho_f\ g\ V_d$ has clear meaning: $\rho_f\ V_d$ is the mass of fluid displaced, times g gives weight of that fluid, which is what buoyant force equals. Recognize that F_B does *not* depend on how heavy the object is; it's purely fluid property and volume. So a heavy metal block of 1 m³ gets the same F_B (≈ 9810 N) as a light plastic foam 1 m³, when both fully submerged. The difference is the metal weighs maybe 77 kN, so net force is 67.2 kN downward (sinks hard), whereas foam weighs maybe 1000 N, so net force ~8810 N upward (pops up). That disparity is the cause of float vs sink. To finalize understanding: Archimedes principle is often summarized as *"buoyancy = weight of displaced fluid."* It's straightforward to apply and is very likely to appear in some form on the FE. So keep it handy.

Topic 03 - Energy, Impulse, and Momentum in Fluids

Topic Introduction: This chapter focuses on the **Energy, Impulse, and Momentum** concepts in fluid mechanics – a core topic for the *FE Mechanical Exam*. You'll revisit how energy is conserved in ideal fluid flow (Bernoulli's principle), how to visualize energy through grade lines, and how Newton's second law applies to flowing fluids (momentum principles). These tools matter on exam day because many questions boil down to **conserving energy along a streamline** or **computing forces from fluid momentum change**. Typical problem archetypes include: calculating pressure or velocity using **Bernoulli's equation**, interpreting an **energy grade line** in a piping system, or finding the **reaction force on a pipe bend or nozzle** using momentum analysis. Mastering this topic means you can confidently decide which principle (energy vs. momentum) solves a given problem – a skill that can save precious time on the exam.

K10.T03.S01 – One-Dimensional Energy Equation (Bernoulli's Equation, No Losses)

Principle Introduction: *Bernoulli's equation* is the backbone of fluid energy analysis. It relates pressure, velocity, and elevation between two points in a frictionless, steady flow:

- Think of it as **conservation of energy per weight** along a streamline (no losses to heat or pumps). Each term – pressure head, velocity head, elevation head – is a form of energy (per unit weight) the fluid possesses.
- **Pressure head**: height fluid could rise due to its pressure ($\frac{P}{\gamma}$). **Velocity head**: height equivalent of kinetic energy ($\frac{v^2}{2g}$). **Elevation head**: height due to potential energy (z).
- In an ideal flow, the *sum* of these heads stays constant from one point to another. In practice, this lets us trade pressure for velocity or elevation changes. For example, fluid speeding up in a nozzle sees pressure drop to keep total energy constant.
- **Exam tip:** Use Bernoulli when you can assume *inviscid steady flow* – it's perfect for quick estimates of pressure or velocity in pipes, nozzles, or open tanks draining, **as long as you can neglect friction and pumps/turbines**.

Equation Passport – Bernoulli's Equation (Steady, Incompressible Flow)

Name & Purpose: *Bernoulli's Equation* – relates the fluid's pressure energy, kinetic energy, and potential energy between two points when no energy is added or lost. It computes one missing term (pressure, velocity, or elevation) given the others, under ideal conditions.

Equation (head form):

$$\frac{P_1}{\gamma} + \frac{v_1^2}{2g} + z_1 \;=\; \frac{P_2}{\gamma} + \frac{v_2^2}{2g} + z_2,$$

where each term has units of length (meters or feet). This is often called the *head* form of Bernoulli's equation because each term represents a head (height).

Variables & Units:

- P_1, P_2 – Fluid pressure at point 1 and 2 (Pa in SI; or psi in USCS).
- v_1, v_2 – Fluid flow velocity at point 1 and 2 (m/s; ft/s).
- z_1, z_2 – Elevation (height) of points 1 and 2 relative to a datum (m; ft).
- γ – Specific weight of the fluid ($\mathrm{N/m^3}$ in SI; $\frac{\mathrm{lb_f}}{\mathrm{ft^3}}$ in USCS). *(Note: $\gamma = \rho g$, where ρ is density.)*
- g – Acceleration due to gravity (9.81 m/s² in SI; 32.174 ft/s² in USCS).

Assumptions & Scope:

- Steady flow (conditions not changing with time).
- Incompressible fluid (constant density; e.g. liquids or low-speed gases).
- Negligible friction losses (no viscosity effects, i.e. no pipe roughness or length losses accounted).
- No mechanical work added or removed between the two points (no pumps or turbines in the section analyzed).
- Along a single streamline (or across a section if flow is well-behaved). *For exam purposes, often applied between two* points in the same flow *connected by streamline.*

Limit Checks (sanity tests):

- If velocity $v_1 \to 0$ (e.g. a stagnant reservoir surface) and point 2 is in the flow, Bernoulli reduces to $\frac{P_1}{\gamma} + z_1 = \frac{P_2}{\gamma} + \frac{v_2^2}{(}2g) + z_2$. This makes sense: the fluid converts static head into velocity head and pressure head.
- If points 1 and 2 are at the **same elevation** ($z_1 = z_2$) and the flow speed is unchanged ($v_1 = v_2$), Bernoulli predicts $P_1 = P_2$. No energy change → no pressure change (consistent with intuition).

Use vs. Sibling Equations: Use Bernoulli's equation *instead of* the extended *Energy Equation with head loss* when you are told to **ignore losses** or when dealing with an "ideal" flow scenario. If frictional losses or pumps are significant, you must use the more general energy equation (Bernoulli + head loss term) rather than the plain Bernoulli form. In short: *Use Bernoulli for ideal flow; use Energy Equation with h_f for real flow with losses.*

Common Exam Traps:

- **Unit mix-ups:** Mixing units in the head equation (e.g. using P in Pa with z in feet). Always convert pressures to head (divide by ρg or use consistent units) before adding to z and $\frac{v^2}{2}g$.

- **Gauge vs. absolute pressure:** Bernoulli's form works with either gauge or absolute pressures **as long as you use the same reference for both points**. A common mistake is mixing a gauge pressure at one point with an absolute at another. If a point is open to atmosphere, its gauge pressure is 0 – a handy reference.

- **Applying Bernoulli across non-connected streamlines:** The equation assumes energy moves along the same streamline. Don't apply it between two unrelated flows (for example, between separate pipes) or across a pump/turbine without including work terms.

- **Forgetting velocity at a free surface:** If one point is a large tank free surface, $v \approx 0$ there (essentially stagnant relative to the outlet flow) – many forget to set that velocity term to zero, which can lead to big errors.

Exam Handbook Search Cues (Not affiliated with or endorsed by NCEES): *Bernoulli equation*, *energy conservation in fluids*, *pressure head*, *velocity head*, *elevation head*. (These keywords will help you quickly find the relevant formula in the exam handbook.)

Footnotes: Keep in mind that Bernoulli's equation assumes the fluid doesn't lose energy to friction – in real pipes, some energy is lost as heat (accounted as head loss h_f in the full energy equation). The exam might either explicitly say "neglect losses" or provide data to compute h_f if needed (e.g. using Darcy–Weisbach, but that's another subtopic). Also note the distinction between γ and ρ: you might see the equation written in terms of ρ (density) as $\frac{P}{\rho g} + \frac{v^2}{2g} + z = \text{constant}$ – it's the same relationship, since $\gamma = \rho g$.

Variations & Related Forms: In more general form (not required for ideal-case exam problems), the **Energy Equation** adds loss and pump/turbine terms: $\frac{P_1}{\gamma} + \frac{v_1^2}{2g} + z_1 = \frac{P_2}{\gamma} + \frac{v_2^2}{2g} + z_2 + h_f - h_{\text{pump}}$ (with h_f for head loss, h_{pump} for head added by a pump – subtract head for a turbine). For the FE exam, if losses aren't negligible, you'd be given h_f or enough info (like pipe length, friction factor f, etc.) to compute it. *Bernoulli's equation is actually a special case of the energy equation when $h_f = 0$ and no pump/turbine in play.* Another variation: **Stagnation Pressure** – if you bring fluid to rest isentropically, the pressure rises to *stagnation pressure* given by Bernoulli (setting $v_2 = 0$ and solving for P_2). This concept appears as the *stagnation head = static head + velocity head*.

Special Notes (Calculator Use): Entering Bernoulli calculations in your FE-approved calculator isn't tricky, but **watch your parentheses**. For example, if solving for velocity using $v = \sqrt{2g(\Delta h)}$, ensure the multiplication $2g(\Delta h)$ is grouped correctly under the square root. Also, some calculators allow storing intermediate results (like computing one side of the equation first). Be mindful of using consistent units throughout – you don't want to accidentally sqrt a number in $\frac{\text{ft}^2}{\text{s}^2}$ thinking it's in $\frac{\text{m}^2}{\text{s}^2}$. Quick tip: solve symbolically on paper (or mentally) for the target term before plugging numbers, so you reduce chances of algebra mistakes on the calculator.

Explanation & Analysis: Bernoulli's equation essentially states that a fluid's **mechanical energy is constant along a streamline** when no energy enters or leaves. In practical terms, this means if a fluid speeds up (higher v), either its pressure must drop or it must come from a lower elevation z. Conversely, if a fluid is forced upward (increasing z), it might slow down or need higher pressure to push it up. Each term in the equation represents an energy *per unit weight* of fluid:

- $\frac{P}{\gamma}$ is the **pressure energy per weight** (how high the fluid would rise in a static column open to the atmosphere – that's why we call it pressure *head*).
- $\frac{v^2}{2g}$ is the **kinetic energy per weight** (the head equivalent of the fluid's velocity). It tells you how much height the fluid's velocity is "worth" – for instance, water flowing at $10\sim\text{m/s}$ has a velocity head of about $5\sim\text{m}$ (since $\frac{10^2}{(}2 \cdot 9.81) \approx 5$ m).
- z is the **potential energy per weight**, simply the height of that point relative to some reference (often taken as the outlet or ground level).

By adding these up at point 1 and point 2 and setting them equal, Bernoulli's equation enforces energy conservation. Let's break down a common use-case: **calculating exit velocity of water from a tank**. Suppose point 1 is the free surface of a large tank (stagnant, so $v_1 \approx 0$, at atmospheric pressure P_1) and point 2 is at a small outlet nozzle lower down. We set $P_1 \approx P_2 \approx$ atmospheric (if the nozzle ejects to air, both points experience atmospheric pressure, so in gauge terms $P_1 = P_2 = 0$). Bernoulli then simplifies to $0 + 0 + z_1 = \frac{v_2^2}{2g} + z_2$. Thus $v_2 = \sqrt{2g(z_1 - z_2)}$. This is the classic **Torricelli's law** for efflux velocity under gravity – directly derived from Bernoulli. On the exam, you might not derive it from scratch; you could recall it. But understanding it via Bernoulli ensures you won't misapply it (for example, it assumes no losses and that P_2 is atmospheric).

Term by term, here's how to avoid pitfalls: ensure $\frac{P}{\gamma}$ terms share the same reference (usually we use gauge so that an open surface $\frac{P}{\gamma} = 0$). Align the datum for z sensibly (often the lowest point in the problem or the outlet). The good news: you can choose any reference for z – only differences in elevation matter. If you accidentally measure z from different datums at each point, you'll inject error. Lastly, interpret results: if you compute a negative pressure from Bernoulli, it might indicate you assumed no losses where actually a pump was needed, or the point is higher than the energy available (sometimes indicating cavitation if pressure drops below vapor pressure, but that's beyond FE scope). On the FE Exam, solving Bernoulli problems often comes down to carefully identifying points 1 and 2, canceling terms that are equal or negligible, and solving for the unknown. Always double-check that your answer makes sense (e.g., no negative velocities or such).

K10.T03.S02 – Energy Grade Line (EGL) and Hydraulic Grade Line (HGL)

Principle Introduction: When engineers design piping systems, they often visualize energy using two reference lines: the **Hydraulic Grade Line (HGL)** and the **Energy Grade Line (EGL)**. These lines are a graphical way to represent Bernoulli's terms along the flow:

- **Hydraulic Grade Line (HGL):** represents the fluid's *piezometric head* (pressure head + elevation head) at each point along a pipe or channel. In practice, if you poke a small vertical tube (piezometer) into the flow, the height the fluid rises to in that tube is the HGL. It's essentially $\frac{P}{\gamma} + z$ plotted as a height above a reference.
- **Energy Grade Line (EGL):** represents the *total head* at each point, which is the HGL plus the velocity head. So EGL = $\frac{P}{\gamma} + z + \frac{v^2}{(}2g)$. This is the full Bernoulli sum (the constant in ideal flow). The EGL is always above the HGL by an amount equal to the velocity head $\frac{v^2}{(}2g)$ at that point.
- These lines help us **interpret energy distribution**: The vertical drop in the EGL between two points quantifies the head loss (energy lost) due to friction or fittings. Meanwhile, the difference between EGL and HGL at a single point is exactly the kinetic energy head.

- **Why it matters for the FE:** You might get conceptual questions asking which line is higher or how a pump or turbine affects the EGL/HGL. For instance, an exam question could show a diagram of a pipe with an EGL and HGL drawn and ask where a pump is located (a pump adds head, causing an upward jump in the EGL). Understanding these lines makes it easier to troubleshoot energy equation problems without crunching numbers, by using a visual sanity check.

Diagram Passport – Understanding HGL vs. EGL

Diagram Title & Role: *Hydraulic Grade Line and Energy Grade Line* – a schematic tool to visualize how pressure and velocity vary along a flow path in terms of head (energy per weight). It helps decide if there's enough pressure to deliver fluid at a certain point and to locate energy losses or additions (like pumps).

Axes and Quantities: Typically, the horizontal axis represents the location along the pipe or channel (distance or specific points like valve, bend, outlet), and the vertical axis represents head (height in meters or feet). There aren't explicit numerical axes on a conceptual EGL/HGL diagram; instead, you draw the lines to scale relative to a reference datum. The **zero level** is often an arbitrary datum (e.g. the outlet elevation or ground level). Heights on the diagram correspond to energy head relative to that datum.

Key Features and Relationships:

- The HGL is the locus of $\left(\frac{P}{\gamma} + z\right)$ at each point. If you imagine **open tubes tapping into the flow**, the water in those tubes rises to the HGL. The EGL is the locus of $(\frac{P}{\gamma} + z + \frac{v^2}{(}2g))$, which is the HGL plus the kinetic energy head.
- **Separation between EGL and HGL:** This vertical gap equals $\frac{v^2}{(}2g)$. Faster flow = bigger gap (because more kinetic energy). If the flow slows down (say pipe diameter increases), velocity head drops and the gap narrows as you move downstream of the expansion.

- **Slope of the lines:** In a real pipe with friction, the EGL will slope downward as you go downstream – that slope represents head loss (drop in total head). The HGL also slopes downward, often roughly parallel to EGL if velocity is constant. A sudden drop in HGL indicates a *pressure drop*, often due to a contraction or valve. A sudden drop in EGL indicates *energy loss* (like across a turbine or an irreversible loss at a sharp entrance). A pump would show up as a sudden rise in both EGL and HGL (adding head).
- At any open reservoir or tank, the HGL and EGL both start at the free surface level (since velocity is near zero, they coincide there). At a pipe outlet discharging to atmosphere, the HGL at the outlet is at the outlet's elevation (pressure = atmospheric = reference zero gauge), and the EGL is a bit above it by the amount of the exit velocity head. Downstream of an outlet into air, the EGL drops abruptly as the fluid's kinetic energy dissipates into the surroundings (this isn't usually drawn beyond the outlet).

How to Read & Use on the Exam: If you're given a diagram or asked conceptually, start by identifying which line is which (EGL is higher, includes velocity head; HGL is lower). **Example reading move:** Suppose a question shows an EGL and HGL along a pipeline and asks for the pressure at a certain point. You can read off the HGL height at that point (relative to a datum) – that height $H = \frac{P}{\gamma} + z$. Subtract the elevation z of the point (from the datum) to get $\frac{P}{\gamma}$. Multiply by γ to get pressure P. This is quicker and less error-prone than plugging into formulas if the diagram is drawn to scale or given with values. Another example: If a pump is present, you'd see the EGL (and HGL) jump up at the pump location by the amount of head the pump adds. You can use the vertical distance of that jump to directly read the pump head increase.

Common Misreads & Pitfalls:

- **Confusing EGL vs HGL:** A frequent mistake is thinking the HGL includes velocity head – it does not. If you erroneously treat HGL as total head, you'll mis-estimate pressures. Remember: HGL is always below EGL unless flow velocity is zero (only then they coincide).

- **Negative pressures interpretation:** If the HGL falls below the pipe elevation (i.e. $\frac{P}{\gamma} + z$ goes below the pipe's vertical position), it indicates the pressure has dropped below atmospheric (suction or vacuum relative to atm). While negative gauge pressure is possible (e.g. siphons), on the exam be cautious: if the HGL dips too low, check if you're expected to consider vapor pressure (to avoid cavitation). Usually the exam won't delve deeply into that, but it might expect you to recognize a siphon scenario.

- **Mixing units or datums:** Ensure you interpret the vertical distances on these diagrams in consistent units (don't read one point's head in feet and another in meters!). Also verify the datum: if the diagram's vertical scale is referenced from an arbitrary level, be careful to subtract elevations correctly.

Exam Handbook Search Cues (Not affiliated with or endorsed by NCEES): *hydraulic grade line*, *energy grade line*, *total head line*, *piezometric head*. (In the exam handbook, these terms will point you to definitions and the relationship between HGL and EGL. Knowing the keywords helps you find the right section quickly under pressure.)

Footnotes: In many fluids problems, especially in water resources or pipe flow, you'll implicitly use HGL/EGL concepts. For example, when using Bernoulli with a head loss term, you're basically saying "total head drops by h_f" – that's the EGL sloping down. It's not necessary to draw the lines every time, but visualizing them can prevent conceptual errors. Also note that "head" is just energy per weight; 1 m of head = 1 m of potential lift, which is 9.81 J/kg of energy. So when you see a pump with 20 m of head, that means it gives 20 m-worth of energy to each kg of fluid (about 196 J/kg). Visual tools like EGL/HGL turn those numbers into a picture, which can be easier to digest.

Variations & Related Concepts: The EGL and HGL concept isn't limited to closed pipes – it's also used in open channel flow (where HGL is the water surface itself, and EGL is water surface plus velocity head, which gives the *specific energy* in open channels). In open channels, velocity head is often small compared to depth, but it becomes crucial near critical flow conditions. However, for FE Mechanical, you likely won't dive deep into open-channel specifics, but it's good to know the analogy. Also, be aware that engineers sometimes use the term **"grade line"** interchangeably with HGL if it's clear from context. In pump and system curves, the term *"Total Dynamic Head"* is essentially the elevation of the EGL at the pump relative to the downstream reference – tying this concept to pump calculations.

Explanation & Analysis: To solidify understanding, imagine a horizontal pipe with water flowing from a tank through a long pipe to a lower outlet. At the tank (upstream), the water is mostly

stationary, so EGL and HGL start at the tank's water surface elevation. As water enters the pipe and gains speed, some of that potential head from the height difference converts to velocity head and some is lost to friction. If you plot the HGL along the pipe: it will start at the tank water surface, then drop gradually along the pipe length because pressure is dropping due to friction (and because some potential energy was converted to velocity). The EGL will start at the same point initially (since velocity head is zero at the tank surface, EGL = HGL there), then as soon as the water is moving, the EGL will be a bit above the HGL. As you move along, both HGL and EGL decline, but remain separated by a roughly constant gap equal to $\frac{v^2}{(}2g)$ (assuming pipe diameter and thus velocity stay constant). Now, if there's a sudden expansion or reservoir at the end, the velocity head will drop (fluid slows down) – so the EGL will drop to meet the HGL at the outlet (because at a free surface or large reservoir, velocity goes to zero, making the two lines meet again).

On an exam question, you might be given numerical values: e.g., "the pressure at point A is 300 kPa at elevation 10 m, and at point B (elevation 5 m) the pressure is 150 kPa and velocity 10 m/s. Determine the head loss between A and B." You can solve that with Bernoulli + h_f. But visualizing EGL: compute total head at A ($H_A = \frac{P_A}{\gamma} + z_A + \frac{v_A^2}{(}2g)$; here v_A might be given or implied), do same for B, the difference $H_A - H_B$ is the head lost. That difference is exactly how much lower the EGL is at B than at A. Being comfortable with HGL/EGL means you're essentially comfortable with Bernoulli's terms. A mental picture of these grade lines can help you double-check your calculations: if you found a higher head at a downstream point than upstream without a pump, something's wrong (violates the expected downward slope of EGL). In summary, EGL/HGL are not new equations to memorize, but rather a *visual extension of Bernoulli and energy concepts*. They help ensure your answers make sense energetically. Many engineers (including myself) like to sketch the HGL/EGL when tackling complex pump-and-pipe systems – it's like having a roadmap of the fluid's energy. Even under exam time pressure, a quick mental or rough sketch of "high points" and "low points" of energy can guide your problem solving and catch mistakes before they happen.

K10.T03.S03 – Euler's Equation (Differential Bernoulli Equation for Inviscid Flow)

Principle Introduction: Bernoulli's equation in its familiar form is actually an *integrated result* of a more fundamental relationship: **Euler's equation** for an inviscid fluid element. Euler's equation is basically Newton's second law applied to an infinitesimal fluid element, with viscous forces neglected.

Key points:

- **Differential form of energy balance:** Euler's equation relates infinitesimal changes in pressure, velocity, and elevation for a flowing fluid. It tells us how pressure changes along a flow if the fluid accelerates or gains elevation.
- For steady flow along a streamline, Euler's equation can be written as $\frac{dP}{\rho} + v\,dv + g\,dz = 0$. This is a compact way to say: a small drop in pressure energy is converted into kinetic or potential energy. Integrating this along a path gives Bernoulli's equation.
- In a more general unsteady scenario, Euler's equation includes time-acceleration effects. For example, if fluid is accelerating in the x-direction (say in a piston or unsteady pipe flow), there's an extra term to account for that acceleration. The general one-dimensional form could look like $-\frac{\Delta P}{\rho} - g\,\Delta z = a_x\,\Delta x$ (which basically is Newton's law: pressure force minus weight = mass * acceleration).
- **Why it matters:** While you may not be directly asked to use Euler's differential form, understanding it deepens your intuition. It explains *why* pressure drops when velocity increases (and vice versa) at the infinitesimal level. Also, recognizing Euler's equation reminds you of its assumptions – no viscosity, which aligns with Bernoulli's assumptions.
- On the FE Exam, Euler's equation might appear as a concept question or a very simplified differential analysis. For instance, knowing that **hydrostatic pressure change** is a special case of Euler's equation (when $v = 0$, it reduces to $dP = -\rho g\,dz$) could be tested in a conceptual question. Or they might expect you to identify Euler's equation among a list of formulas.

Equation Passport – Euler's Equation (Inviscid Flow Element)

Name & Purpose: *Euler's Equation* – describes the balance of forces on a fluid particle moving in a flow, relating pressure gradients to acceleration and weight. It's used to derive Bernoulli's equation under steady conditions, or to analyze pressure changes in accelerating (unsteady) fluids. Essentially, it's Newton's second law ($F = ma$) for a frictionless fluid slice.

Equation (steady flow form):

$$\frac{dP}{\rho} + g\,dz + v\,dv \;=\; 0,$$

which states that a small increase in elevation ($dz > 0$) or increase in speed ($dv > 0$) must be accompanied by a drop in pressure ($dP < 0$) for the equation to hold (and vice versa).

For reference, a one-dimensional form allowing acceleration in the flow direction x (unsteady case) is:

$$-\frac{\Delta P}{\gamma} - \Delta z = \frac{a_x}{g}\,\Delta x,$$

where a_x is the fluid's acceleration in the x direction. This form says pressure drops in the direction of acceleration (like a accelerating slug of fluid has lower pressure at its front than its back). If acceleration is zero (steady uniform flow), this reduces to $\frac{\Delta P}{\gamma} + \Delta z = 0$, which is just the static fluid relation.

Variables & Units:

- P – Pressure (Pa or N/m²; in differential form dP is a very small pressure change).
- ρ – Fluid density (kg/m³). Using ρ is common in differential form; note $\frac{dP}{\rho}$ has units of $\left(\mathrm{N/m^2}\,\frac{)}{(}\,\mathrm{kg/m^3}\right) = \frac{\mathrm{m^2}}{\mathrm{s^2}}$, which when multiplied by $\frac{1}{g}$ becomes a length (head).
- γ – Specific weight of fluid (N/m³). Sometimes the equation is written with γ for convenience: $\frac{dP}{\gamma} + dz + \frac{v\,dv}{g} = 0$ (dividing everything by g).
- z – Elevation (m). (dz is a small change in height of the fluid element).

- v – Velocity along the streamline (m/s). (dv is a small change in velocity).
- a_x – Local acceleration in the x direction (m/s²) if considering unsteady accelerating flow.
- x – Distance along the flow direction (m). (Δx is a small distance between two points in flow direction).

Assumptions & Scope:

- Inviscid fluid (no viscous forces, so no friction terms appear in the equation).
- Applicable along a streamline (for the steady-flow form) or along the flow direction for an accelerating flow. Euler's equation can be generalized vectorially, but for FE exam purposes, we stick to 1-D along streamline.
- For the steady form: flow is steady (no explicit time dependence). For the unsteady form: allows a temporally accelerating flow in one direction.
- No shaft work input or output (like Bernoulli, this is derived from Newton's $F = ma$ without any additional energy sources).

Limit Checks:

- **Static fluid:** Set $v = 0$ (and thus $dv = 0$) in the steady form. It reduces to $dP + \rho g\, dz = 0$, or $\frac{dP}{dz} = -\rho g$. This is the *hydrostatic pressure gradient* – a reassuring special case: pressure increases with depth. So Euler's equation contains that scenario perfectly.
- **Flat horizontal flow:** Set $dz = 0$. Then $dP = -\rho\, v\, dv$. If velocity increases (dv positive), dP is negative – pressure drops. If velocity decreases, dP is positive – pressure rises. This is a differential statement of the Venturi effect (pressure-velocity tradeoff).
- **No acceleration & level ($dv = 0, dz = 0$):** Then $dP = 0$. Pressure is constant along that bit of streamline, consistent with our expectation (no change in conditions, no change in pressure).

Use vs. Sibling Equations: Euler's equation is essentially the differential precursor to Bernoulli's equation. *Use Euler's equation instead of Bernoulli when* you want to derive or understand the point-by-point change in pressure, or when dealing with problems that naturally involve small increments (not common in exam problems explicitly). In FE exam problems, you're more likely to apply Bernoulli's integrated form for practical calculations. But Euler's equation might be referenced conceptually or used in derivations of other formulas (like deriving the Bernoulli constant or showing that stagnation pressure formula). If viscosity matters, neither Euler nor Bernoulli is directly valid – you'd move to the Navier-Stokes equations or empirical formulas (beyond FE scope except in a very qualitative sense).

Common Exam Traps:

- **Misidentifying forces:** Euler's equation stems from $F = ma$ on a fluid particle. Forgetting a term is like forgetting a force. For example, leaving out $g\, dz$ would ignore weight; leaving out $v\, dv$ would ignore acceleration. Each term has a physical force interpretation (pressure force, gravity, inertia). If a problem ever asks which term corresponds to which effect, keep that in mind.
- **Sign confusion:** The form $\frac{dP}{\rho} + v\, dv + g\, dz = 0$ can be tricky with signs. It's derived assuming dz is positive upwards and pressure decreases upward. Students sometimes mix up the sign on $g\, dz$. A good way to remember: in a static case ($dv = 0$), $dP = -\rho g\, dz$ must hold (pressure increases downward), so the signs in Euler's equation should honor that (hence $+g\, dz$ in the left term leads to dP negative when dz positive).
- **Units mix in differential form:** If you plug numbers, ensure consistency (often easier to derive symbolically and then integrate). For instance, a slip could be using ρ in $\mathrm{kg/m^3}$ and g in $\mathrm{ft/s^2}$ inadvertently – avoid mixing SI and USCS mid-calculation.

Exam Handbook Search Cues (Not affiliated with or endorsed by NCEES): *Euler's equation*, *differential Bernoulli*, *inviscid flow equation*, *pressure gradient*. (Searching these terms in the handbook index or fluid mechanics section will locate the formula and its explanation, which could be useful for quick reference if a question specifically references Euler's equation or asks for a differential relation.)

Footnotes: You might wonder, "Will I ever need to actually use Euler's equation on the FE exam?" In most cases, you won't be asked to perform calculus during the exam – but understanding it can help if a conceptual question arises. For example, if the exam asks *"Which equation is the basis for the derivation of Bernoulli's principle?"*, the answer is Euler's equation. Also, Euler's equation in fluid mechanics is different from "Euler's formulas" in math or other contexts – here it strictly refers to the fluid dynamics application. One more bit: Euler's equation assumes no viscosity, which is why it's only accurate where friction is negligible. If you included viscosity, you'd end up with the **Navier-Stokes** equations (definitely not something FE expects you to solve, but just for context).

Variations & Related Forms: In fluid dynamics, Euler's equation can be written in many forms (pressure gradient form, acceleration form, etc.). A commonly cited variant is the *head form for steady flow*: $\frac{dP}{\gamma} + dz + \frac{v\, dv}{g} = 0$. Integrating this from point 1 to 2 yields the head form of Bernoulli (as we showed earlier). Another related concept is the **Bernoulli equation with an unsteady term** (often called the *unsteady Bernoulli* or *extended Bernoulli* equation): $\frac{\partial \Phi}{\partial t} + \frac{v^2}{2} + gz + \frac{P}{\rho} = \text{constant}$, where Φ is the velocity potential. This goes beyond what FE Mechanical will test, but it's good to know that Euler's equation is the stepping stone to many advanced fluid relationships.

Explanation & Analysis: Let's interpret Euler's steady-flow equation term by term in plain language. Multiply $\frac{dP}{\rho} + v\, dv + g\, dz = 0$ through by ρ to avoid fractions: $dP + \rho v\, dv + \rho g\, dz = 0$. This is essentially a force balance on a tiny fluid element of mass $\rho\, dV$ (with dV an infinitesimal volume). The term dP represents a pressure force difference across the element (pressure pushing from behind minus pressure resisting ahead). The term $\rho g\, dz$ is the weight of the element (if dz is positive upward, $\rho g\, dz$ is the weight component along the streamline – which would actually be negative in the upward direction, hence the sign). The term $\rho v\, dv$ is the inertial force (mass × acceleration, since dv is acceleration times an infinitesimal time). Setting their sum to zero is Newton's second law: Pressure force + gravity force + inertial force = 0 (in equilibrium from the frame of the fluid element moving with the flow). Solving that differential equation (by integration) recovers Bernoulli's constant.

For a sanity check, consider a specific scenario: **a fire hose nozzle during start-up**. When water first begins to accelerate through the nozzle, it's unsteady – pressure at the hose inlet might be high and the water is picking up speed. Euler's equation (in unsteady form) would tell us that pressure at the nozzle inlet must exceed the

pressure at the outlet by an amount related to both velocity change *and* the water's acceleration. The unsteady term $a_x\,\Delta x$ is only present while the flow is accelerating. Once the flow is steady, $a_x = 0$ and we revert to the simpler steady-state form. So if a question ever asks about pressure differences in accelerating fluids (not common, but possible conceptually), remember that an accelerating fluid behaves like you need extra pressure gradient to accelerate it (just like pushing a car requires overcoming inertia). The steady Euler's equation is more likely to be tested indirectly – for example, through the hydrostatic relation or the concept of pressure-velocity coupling.

To use Euler's equation in a problem, you would typically integrate it. For example, integrate $\frac{dP}{\rho} + g\,dz = 0$ in a static fluid: $\int \frac{dP}{\rho} = -\int g\ dz$, yielding $P_2 - P_1 = -\rho g(z_2 - z_1)$, which you rearrange to $P_1 + \rho g z_1 = P_2 + \rho g z_2$ – that's a constant *pressure head* result, consistent with Bernoulli for $v = 0$. The FE exam might not ask you to do such integrals explicitly, but it could ask, for instance, *"What differential equation represents frictionless flow along a streamline?"* – that's Euler's equation. Having this background will let you identify it with confidence.

K10.T03.S04 – Impulse–Momentum Principle for Fluid Flow (Control Volume Form of Newton's 2nd Law)

Principle Introduction: Fluids can exert forces due to their momentum change, just as solid masses do. The impulse–momentum principle is Newton's second law written for a fluid control volume: the net force on the fluid equals the rate of change of momentum, accounting for the momentum carried out of the control volume minus the momentum brought in.

Key points include:

- **Control Volume Approach:** Instead of tracking one particle, we look at a region in space (control volume) and consider fluid mass flowing in and out. The net force on the fluid in that region equals the outgoing momentum flux minus incoming momentum flux (because that difference is the momentum change of fluid passing through).
- **Formula in words: Sum of Forces = mass flow * change in velocity.** In equation form: $\sum F_x = \dot{m}(v_{2x} - v_{1x})$ for the x-direction, and similarly for y-direction. Here $\dot{m}$ is mass flow rate, and v_{1x}, v_{2x} are the average fluid velocities in and out in the x-direction. If there are multiple outlets/inlets, you sum up $\dot{m}\mathbf{v}$ for all, careful with sign (outflow momentum is positive, inflow momentum subtracts).
- **Forces considered:** $\sum F$ includes all external forces on the control volume fluid: pressure forces on the control surface, weight of the fluid (if considering vertical direction), and any restraining forces from pipes or structures. Often, the quantity of interest is the force the fluid exerts on a pipe bend or nozzle; by Newton's third law, it is equal in magnitude and opposite in direction to the force the pipe exerts on the fluid.
- **Why it matters on the FE Exam:** Many problems ask for forces due to fluid momentum change – for example, "What anchor force is needed to hold a pipe elbow in place given flow conditions?" or "Calculate the force on a plate struck by a jet of water." Using the impulse–momentum principle is the direct way to solve these. It's a complement to energy methods: energy equations won't give you forces, but momentum equations will.
- **Approach:** Identify control volume boundaries (often just around the object of interest, like an elbow or nozzle), account for pressure forces on inlet/outlet faces (pressure * area = force) and momentum flux change, and set $\sum F = \dot{m}\Delta v$. Careful with directions: define a positive direction (usually along the direction of flow for convenience in each axis). We will break this down further in explanation.

Equation Passport – Linear Momentum (Impulse–Momentum) Equation

Name & Purpose: *Linear Momentum Equation (Control Volume form)* – calculates the net force required due to fluid flow by equating it to the change in momentum flow through a control volume. It's essentially the fluid-flow version of $F = ma$, where ma becomes $\dot{m}\Delta v$ for steady flow (mass per time times change in velocity gives force). Use this equation to find reaction forces on pipe fittings, forces by jets on surfaces, or thrust from nozzles.

Equation (in one dimension):

$$\sum F_x = \dot{m}\,(v_{2x} - v_{1x}),$$

$$\sum F_y = \dot{m}\,(v_{2y} - v_{1y}),$$

for the x and y directions respectively. If the flow turns, $\mathbf{v}_1$ and $\mathbf{v}_2$ components will differ by angle. A more general vector form can be written as

$$\sum \mathbf{F} = \dot{m}(\mathbf{V}_{\text{out}} - \mathbf{V}_{\text{in}})$$

These forms assume steady flow (so mass flow in =mass flow out $= \dot{m}$) and account for one inlet and one outlet; with multiple flows, sum the $\dot{m}\mathbf{V}$ terms:

$$\sum \mathbf{F} = \sum_{\text{outlets}} \dot{m}\ \mathbf{V} - \sum_{\text{inlets}} \dot{m}\ \mathbf{V}$$

Variables & Units:

- $\sum F_x, \sum F_y$ – Sum of external forces acting on the control volume fluid in the x or y direction (Newtons, N; or pounds-force, lbf). This includes pressure forces on control surfaces (which can be negative if opposing flow), gravity components (in vertical direction), and any applied forces (like a pipe's support force on the fluid).

- $\dot{m}$ – Mass flow rate of the fluid (kg/s; or slug/s in US units, but usually easier: $\dot{m} = \rho Q$ where Q is volume flow in m³/s or ft³/s).

- v_{1x}, v_{2x} – Initial and final velocity components in the x-direction (m/s). If the pipe bends, one of these might be the inlet velocity, the other the outlet velocity projection on the x-axis.

- v_{1y}, v_{2y}– Initial and final velocity components in the y-direction (m/s). (These will be zero for a horizontal flow turning horizontal, etc., depending on geometry.)

- $\mathbf{V}_{\text{in}}, \mathbf{V}_{\text{out}}$– Velocity vectors at inlet and outlet (m/s). Sometimes easier to work with magnitude and flow angle: e.g., if a flow turns

by angle θ, and speed remains $|V|$, then $v_{2x} = |V| \cos\theta$, $v_{2y} = |V| \sin\theta$.

Assumptions & Scope:

- Flow is **steady** (mass flow and velocity at inlets/outlets constant in time), so we don't have to worry about accumulating or depleting momentum inside the control volume over time. If flow were unsteady, the equation would have an extra term for the time rate of change of momentum inside the CV. FE problems almost always assume steady state for momentum problems unless explicitly stated otherwise.

- Control volume chosen such that mass flow crossings are known (through inlets/outlets) and that the forces of interest are accounted (choose control surfaces along where you know pressure or want to find force from structures).

- Incompressible flow is typically assumed (so $\dot{m} = \rho A v$ remains constant if one inlet one outlet, aside from slight density variation not being a factor in momentum unless shock or compressibility considered – not likely in FE Mech scope except perhaps for an ideal gas jet where density might be given).

- Gravity force considered only if vertical direction is involved (e.g., a vertical jet or a fluid turn with weight). Often in horizontal pipe bend problems, we can ignore weight in horizontal force balance but include in vertical if needed.

- The "forces" in the equation are typically *external forces on fluid*: pressure forces on the control volume surfaces, weight of fluid in CV, and reaction from structures. *Internal forces (like fluid viscosity) are accounted indirectly by momentum flux; we assume by choosing a suitable CV and steady state that we don't need to explicitly include viscous drag on CV surfaces if they coincide with solid walls.*

Limit Checks:

- **No change in velocity:** If $v_{2x} = v_{1x}$ (and similarly in y), then $\sum F = 0$. This makes sense: if the fluid's momentum doesn't change, net force on it is zero (ignoring weight). For example, straight pipe with constant diameter (no pressure difference ends if frictionless, or balanced by friction with walls which is internal to CV not shown as an external force in this simple momentum balance) yields no net force needed in ideal case.

- **Completely stopped flow:** If a fluid stream is brought to rest (like hitting a dead-end or a plate head-on that stops it), $v_2 = 0$ and $\sum F = -\dot{m} v_1$. The negative indicates the force on fluid is opposite to its direction of motion. In other words, the obstruction must exert a force equal to $\dot{m}v$ to stop the fluid (and the fluid exerts equal and opposite force on the obstruction). If $\dot{m}$ doubles or velocity doubles, the stopping force doubles – momentum change is linear in these factors (contrasting with energy which would quadruple for doubling velocity).

- **U-turn scenario:** If a fluid makes a 180° turn (goes out opposite to in direction) with same speed, $v_{2x} = -v_{1x}$. Then $\Delta v_x = -2v_{1x}$, so $\sum F_x = \dot{m}(-2v_{1x})$. The magnitude of force is $2\dot{m}v$ – double what it would be to just stop it. That matches intuition: reversing flow direction imparts more momentum change than just stopping it.

Use vs. Sibling Equations: Use the momentum (impulse–momentum) equation instead of energy equations when the problem asks for forces or momentum effects. For example, to find how strongly a jet pushes on a plate, energy methods (Bernoulli) aren't directly helpful – you need momentum. Conversely, if the problem is about pressure drop or head loss, energy/Bernoulli is your go-to, not momentum. In some cases, you might use both: e.g. to find the force on a nozzle, you might use Bernoulli to find velocities or pressures then momentum to find force. Remember, **Bernoulli (energy) answers "how fast/what pressure?", Momentum answers "how much force?"**. They're complementary. Don't confuse the two: plugging numbers into Bernoulli will not give you force, and plugging into momentum won't give you pressure unless you include pressure forces explicitly.

Common Exam Traps:

- **Forgetting pressure forces:** A big one. When using $\sum F = \dot{m}\Delta v$, $\sum F$ must include pressure forces at the inlets and outlets of your control volume (unless those pressures are zero gauge like an open jet). Many students erroneously set $\sum F$ equal to just the support reaction and neglect that, say, at an inlet of a pipe bend, the upstream pressure is pushing in the opposite direction of flow, contributing a force. The safe approach: draw a free-body diagram of the control volume, put $P \times A$ arrows at all openings (pointing *into* the CV for inlet pressure acting on fluid, out of CV for outlet pressure acting on fluid), weight force if gravity, and any external holding forces. Then apply momentum balance with consistent sign directions.

- **Sign convention confusion:** It's easy to mix up signs. Define a positive direction (e.g. positive x along the outlet flow direction). Then stick with it: if fluid momentum in that direction increases from inlet to outlet, the fluid gained momentum in +x, meaning there must be a net +x force on it. The reaction on the pipe would be opposite (−x). You might solve for the force on fluid and then be asked for force on the pipe (just switch the sign). Keep track using Newton's third law carefully.

- **Mixing up mass flow vs volumetric flow:** The equation needs $\dot{m}$. If they give you volume flow Q, you must multiply by density ρ to get $\dot{m}$. Using Q directly in $\dot{m}\Delta v$ without ρ will give a wildly wrong answer (off by factor of 1000 for water if you forget density). A common pitfall is when working in US units: if flow is given in, say, $\frac{\text{ft}^3}{\text{s}}$ and velocity in ft/s, you might plug them in and forget to multiply by ρ (slugs/ft³). Always check units: $\dot{m}v$ yields N if in SI (since kg/s * m/s = kg·m/s² = N), or lbf if in consistent US units. If you end up with unit like $\text{slug} \cdot \text{ft/s}^2$, convert slug·ft/s² to lbf (1 slug·ft/s² = 1 lbf by definition under standard gravity).

- **Assuming pressure at outlet is zero without basis:** If the outlet discharges to atmosphere, yes, pressure force at outlet is ambient (often we take gauge 0). But if the outlet is still a closed pipe going elsewhere, you cannot drop that term. Use gauge pressures relative to atmosphere to simplify: then any free jet outlet has 0 gauge pressure and simplifies analysis.

Exam Handbook Search Cues (Not affiliated with or endorsed by NCEES): *momentum equation*, *force on bend*, *impulse fluid*, *Newton's second law fluids*. (These terms in the handbook correspond to the momentum principle formulas and examples; knowing them can help you quickly access the relevant equations on exam day if needed.)

Footnotes: The impulse-momentum principle is essentially the same physics as a baseball hitting a glove or a car crash, just applied to fluid continuously flowing. Sometimes students try to

apply energy where momentum is needed – a classic mix-up is trying to use Bernoulli to figure out the force of a jet on a wall. Energy can tell you pressure or velocity, but **force** requires momentum. Keep that clear in your mind. Also, remember that momentum is a vector. You often need to break forces and velocities into components – solving two equations (one for x, one for y). The FE exam might simplify things by confining questions to one direction (like a water jet hitting a wall head-on, purely x-direction), but be prepared for angled flows (like a pipe bend with a turn). In such cases, find forces in each direction, then combine (resultant) if asked. Typically, the exam will either ask for components or the magnitude of the resultant force.

Variations & Related Forms: The full Navier–Stokes momentum equations are beyond FE scope, but this control-volume form is actually derived from them under steady conditions. For multiple inlet/outlet systems, the momentum equation generalizes to

$$\sum \mathbf{F} = \sum_{\text{outlets}} \dot{m}\,\mathbf{V} - \sum_{\text{inlets}} \dot{m}\,\mathbf{V}$$

Also, there is an angular-momentum counterpart (used for turbines, etc.), which says

$$\sum \mathbf{M} = \dot{m}(r_2 V_{\theta 2} - r_1 V_{\theta 1})$$

(probably not needed for FE Mechanical unless dealing with rotating machinery concepts). In fluid mechanics, the impulse–momentum principle can also be phrased in terms of pressure integrals and velocity profiles for more complex flows, but for FE problems we usually assume uniform velocity across a section and use $P \times A$for forces. One more related concept: thrust (like rocket or jet engine thrust) is exactly this momentum-change principle—mass flow times exit velocity (minus any inlet momentum if air is coming in). So, the rocket problem is just a special case: no inlet mass (or negligible) and high-speed outlet mass, force $= \dot{m} v_{\text{exhaust}}$.

Explanation & Analysis: Let's walk through applying the momentum principle with a concrete example: **force on a 90° pipe elbow.** Water is flowing through a horizontal pipe that turns 90° upward. We want the force the elbow exerts on the water (and by reaction, the force needed to hold the elbow in place). We define a control volume enclosing the elbow (cut the CV at a cross-section a little before the turn (inlet) and at a cross-section after the turn (outlet), and the walls of the CV are the pipe interior walls).

For simplicity, assume steady flow, inlet area = outlet area (so speed is same if diameter constant, though direction changes). Inlet (1) has velocity $\mathbf{V}_1$to the right (x-direction), outlet (2) has velocity $\mathbf{V}_2$upward (y-direction). Gauge pressure at inlet and outlet might not be the same; say we know them or can compute one via Bernoulli if needed. Now, write momentum in x-direction: $\sum F_x = \dot{m}(v_{2x} - v_{1x})$. What are the forces in x? At the inlet cross-section, pressure P_1acts on area Apushing fluid into the CV to the right (that is a force on fluid in +x direction). At the outlet cross-section, pressure P_2acts on area Apushing fluid into the CV from the top, which has no x-component (it's vertical force). The pipe wall will exert a force on the fluid (likely pushing it to change direction). Let $F_{\text{wall},x}$be the wall force on fluid in x (likely negative, pushing opposite to flow to turn it). Here $v_{2x} = 0$(since outlet flow is straight up, no x-component) and $v_{1x} = V$(the speed in horizontal direction at inlet). So $\dot{m}(0 - V) = -\dot{m}V$. This is the change in momentum of fluid (it lost some x-momentum, going from $V$to 0 in x). Thus $\sum F_x = -\dot{m}V$. Summing forces in x: $+P_1 A$(inlet pressure pushes fluid in +x) $+0$from outlet pressure (no x comp) $+F_{\text{wall},x} = \dot{m}(0 - V) = -\dot{m}V$. Solve for wall force: $F_{\text{wall},x} = -\dot{m}V - P_1 A$. This might come out negative (depending on sign conventions; it basically indicates the wall is pushing opposite to flow). The reaction force on the pipe by fluid would be opposite: equal magnitude in +x (action-reaction).

Do the same for y-direction: $\sum F_y = \dot{m}(v_{2y} - v_{1y})$. Inlet has no y velocity ($v_{1y} = 0$), outlet has $v_{2y} = V$ upward (assuming same speed just turned). So $\dot{m}(V - 0) = +\dot{m}V$. Net force on fluid in y must be $\dot{m}V$ upward. Forces in y: inlet pressure has no y component, outlet pressure $P_2 A$ pushes downward on fluid (into CV), that's -y direction force on fluid, weight of fluid in CV (if significant, downward), and the pipe wall will exert a force (likely upward to deflect flow). So: $-P_2 A$ (downward) $-W$ (weight, downward) $+F_{\text{wall},y} = \dot{m}V$ (upward positive). Solve: $F_{\text{wall},y} = \dot{m}V + P_2 A + W$. That $F_{\text{wall},y}$ is upward (expected, pipe pushes fluid up). The pipe feels a downward reaction equal to that.

This breakdown might seem lengthy, but it's straightforward when you practice: *momentum out minus in = net force*. The algebra is simpler if you choose CV such that one side has atmospheric pressure (like a jet into air, $P_{\text{out}} = 0$ gauge). Then PA terms drop out for that side. Many FE problems make it easier by either giving pressures or by being in atmospheric exit conditions. The crucial part is aligning directions and including all forces.

One common scenario: **Water jet hitting a flat plate.** If the plate is perpendicular to flow and stops it dead, the force on the plate is $\dot{m}v$ (essentially $\dot{m}(0 - v_{\text{in}})$ with no pressure on the free jet after impact aside from atmospheric). If the plate is at an angle or a curved vane (like in turbines, which redirect flow), you'd consider components. A 180° turn (like a U-shaped sprinkler bend) yields roughly $2\dot{m}v$ force as discussed.

As an engineer, I remember initially confusing energy and momentum methods. A helpful memory: **Energy is scalar (use for head, pressure, velocity magnitude), Momentum is vector (use for force, direction changes).** Whenever the question explicitly involves a force or a support reaction due to fluid motion, I immediately think "Momentum principle – draw CV, include pressure and momentum flux." With practice, these become almost automatic moves. On exam day, if you see a fluid force problem, take a deep breath and systematically apply this: 1) define control volume, 2) draw all force vectors (pressure, weight, reaction), 3) write momentum balance in each direction. This structured approach prevents missing any term and leads you to the answer reliably.

K10.T03.S05 – Forces from Momentum Change in Applications (Bends, Nozzles, and Jet Impingement)

Principle Introduction: Building on the momentum principle, this subtopic focuses on common **applications** where fluid momentum change produces forces: pipe bends, nozzles, and vanes (like those in turbines or deflectors). These are the real-world cases you'll see in problems. Each has some quirks: pipe bends have internal pressure pushing on bends, nozzles often involve a large pressure drop and high exit velocity (thrust), and vanes experience impulse from fluid redirection. The key is always the same physics – *momentum change* – but let's highlight specifics for each:

- **Pipe Bends (Elbows and Turns):** A pipe bend experiences a force because fluid momentum changes direction inside it. Typically, you'll need to find the resultant force that the fluid exerts on the bend (and thus the equal opposite force the bend exerts on the fluid). The

force has components due to momentum change and due to pressure on the bend's interior surfaces. Exam problems usually provide inlet/outlet diameters (possibly equal), flow rate, and pressures, and ask for the magnitude and direction of the force on the support. The strategy: compute $\dot{m}(v_{\text{out}} - v_{\text{in}})$ in each direction, include pressure force differences PA if pressure differs between inlet and outlet, and combine components. Remember the fluid's force on the bend is opposite in direction to the bend's force on fluid from the momentum equation.

- **Nozzles (and Sprays):** A nozzle converts pressure into kinetic energy – high-speed flow out the end. The exiting jet carries momentum that wasn't there at the inlet (relative to the nozzle), so there's a thrust force pushing the nozzle backward (like a rocket). If the nozzle is just a straight reducer ending in open air, the force on the nozzle is mainly from the pressure at its inlet pushing it forward minus the reaction of accelerating water backward. Simplified, thrust $F \approx \dot{m}v_{\text{exit}} + (P_{\text{in}} - P_{\text{out}})A_{\text{in}}$ (the pressure difference across the nozzle times area gives an extra push). Often P_{out} is atmospheric so that term simplifies. On the exam, you might be asked for the force to hold a fire hose (nozzle reaction) given pressures and flow, or the anchor force at a reducer fitting.
- **Vanes and Jet Impingement:** This covers cases like a water jet hitting a flat plate or a curved blade (think of a turbine blade being hit by a jet, or a plate deflecting flow). If the jet bounces off or is deflected, the change in momentum can be large. A stationary flat plate that stops a jet will experience a force $F = \dot{m}v$ (as mentioned earlier). If the plate deflects the flow by some angle (say 90°), then the force depends on how much velocity component is lost in that direction. For example, a jet hitting a splitter vane that turns flow 90° will feel a force equal to $\dot{m}v$ in the original jet direction (since that component goes to zero). If the flow is reversed 180°, force is about $2\dot{m}v$. If the vane is symmetrical (flow split equally), you distribute momentum accordingly. The exam may ask a simple variant like: *"Water jet (velocity X, flow Y) strikes a flat vertical plate and is turned 90° (flows along the plate). What is the force on the plate?"* You'd calculate $\dot{m}v$ essentially.

Definition Passport – *"Reaction Force" due to Fluid Momentum*

Plain-language Definition: A **reaction force** in fluid flow is the force that arises on an object (pipe bend, nozzle, blade, etc.) because the fluid's momentum is changing. By Newton's 3rd law, if the fluid's momentum is redirected or accelerated, the fluid pushes back on whatever caused that change. For example, if a nozzle accelerates water forward, the water pushes the nozzle backward (that's the reaction force).

Where it matters (exam impact): Reaction forces show up in problems about supports and restraints in piping systems (to prevent pipes from blowing off when valves change flow direction) and in analyzing impact of jets on surfaces (like calculating how much force a jet of water exerts on a wall or turbine blade). These are common FE exam questions in the fluids section – you might be asked to compute the force required to hold a fire hose, or the force on a vane in a given flow. Recognizing that momentum change is the source of the force is the first step in solving those quickly.

Pitfall or confusion point: A common misunderstanding is **mixing up pressure force and momentum force**. They often act together. Some think a bend's force is just due to pressure on one side; others think it's just momentum change. In reality, both contribute: the pressure distribution in the bend and the momentum flux change each play a role. Another confusion: direction of force. Always clarify **force on fluid vs force on object**. Momentum equations give force on fluid; the problem usually wants force on the object (pipe or plate), which is equal in magnitude but opposite in direction. If you forget to switch the sign (or conceptually the direction), you'll give the answer for the wrong entity.

Micro-check: *True or False:* Doubling the flow rate (mass flow) through a given pipe bend will double the resultant force on the bend. *(Answer: True – roughly. The momentum term $\dot{m}\Delta v$ doubles if $\dot{m}$ doubles (assuming velocity change stays same). Note that if doubling flow also changes velocity magnitude or pressure difference, the relation could be more complex, but generally force scales with flow rate.)*

Exam Handbook Search Cues (Not affiliated with or endorsed by NCEES): *jet force*, *bend reaction*, *nozzle thrust*, *momentum flow*. (These can help locate example problems or formulas related to these applications in the handbook or any reference section.)

Special Notes (Calculator and Units): When calculating these forces, it's usually straightforward arithmetic once you've set up the equations. But **keep an eye on units** – force units can be tricky if you're mixing unit systems (e.g., using GPM (gallons per minute) for flow, psi for pressure, etc., you'd convert to consistent units first). For calculator use: break into components. Many FE-approved calculators have vector capabilities, but it's overkill here; just compute F_x and F_y separately, then do $\sqrt{F_x^2 + F_y^2}$ if needed for resultant. Also, be cautious with angles: if asked for direction, an inverse tangent $\arctan\left(\frac{F_y}{F_x}\right)$ gives angle of resultant (with attention to quadrant). Practice resolving directions to avoid sign errors on the calculator (some prefer to just draw to scale and eyeball which quadrant – which is fine for checking).

Explanation & Analysis: Let's analyze each application scenario briefly, highlighting how to solve them and what the results mean:

- **Pipe Bend Example:** Imagine a pipe elbow turning 45° upward carrying water. We have pressure P_1 and velocity V at inlet (horizontal), and pressure P_2, velocity V at outlet (45° upward). The mass flow $\dot{m} = \rho AV$ (assuming constant area). We want the resultant force on the elbow. The fluid momentum change has an x-component (reducing from V to $V\cos 45°$ in x) and a y-component (increasing from 0 to $V\sin 45°$ in y). We'd calculate: $\Delta v_x = V\cos 45° - V = -0.293V$ (negative means momentum in +x decreased) and $\Delta v_y = V\sin 45° - 0 = 0.707V$. Then $F_{\text{fluid},x} = \dot{m}\Delta v_x$, $F_{\text{fluid},y} = \dot{m}\Delta v_y$. Next include pressure forces: at inlet, pressure P_1 acts on area A pushing fluid in +x; at outlet, P_2 acts on area A pushing fluid in a direction 45° downwards (with components in -x and -y on the fluid). We'd add those to get net force on fluid. Solving gives us $F_{\text{fluid},x}$ and $F_{\text{fluid},y}$. The negative x result indicates net force on fluid is opposite flow direction in x (which is expected; the bend pushed it). The positive y result indicates net force on fluid upward. Now the force on the elbow (on the pipe) is opposite: +x and -y (pipe feels push in +x (downstream direction) and downwards). The magnitude can be found. Physically, the

pipe wants to "kick" in the direction the flow was originally going (because it has to push the fluid away from that path) and downward (because it has to push the fluid up). Engineers reinforce bends and often use thrust blocks or anchors because these forces can be large. On the exam, after computing, double-check if the question asks for magnitude and maybe a direction ("the pipe experiences a force of X N directed 45° downwards from the upstream direction" or so).

- **Nozzle Thrust Example:** Consider a fire hose nozzle: water enters at pressure P_1 with negligible velocity (in hose), exits to atmosphere at velocity V_{exit} (high) with $P_2 =$ atmospheric. The hose/nozzle assembly feels a backward thrust. Using momentum: Inlet momentum ~0 (low velocity), outlet momentum $\dot{m}V_{\text{exit}}$ outward. So fluid gained forward momentum, meaning a net forward force on fluid. That force came from pressure inside the hose pushing fluid out. The equal and opposite reaction is the nozzle being pushed back. A quick calc: $F_{\text{nozzle}} = \dot{m}V_{\text{exit}}$ (backward) plus a term for pressure difference across the nozzle: actually, deriving properly, $\sum F_x = \dot{m}(V_{\text{exit}} - 0)$, forces: $P_1 A_{\text{nozzle}}$ pushing forward on fluid, atmospheric pressure at exit pushing back on fluid (small since exit area is smaller usually, but if we take CV at exit plane, that's just outflow no pressure force since outside is atmos). So $P_1 A = \dot{m}V_{\text{exit}}$. The force on fluid is forward = $P_1 A$. The reaction on nozzle is backward = $P_1 A$ (which equals $\dot{m}V$). If numbers: say $P_1 = 500$ kPa gauge, nozzle diameter 0.02 m, $\dot{m}$ computed etc., you get a force maybe tens of Newtons. Always check: higher pressure and flow = bigger thrust, as expected. On the FE, maybe you'll directly do $F = \dot{m}V$ if given flow and velocity, or $F = (P_1 - P_{\text{atm}})A_{\text{in}}$ if given pressure. They're equivalent by Bernoulli linking P_1 and V for a nozzle.

- **Jet Impingement Example:** A common textbook scenario: a horizontal jet hits a vertical plate and splashes sideways. If the plate is flat and the jet comes to a stop (in the x-direction) upon impact (fluid goes out up/down maybe), the force on the plate is $\dot{m}v_{\text{jet}}$ to the right (fluid pushes plate to right, plate pushes fluid leftward). If the jet splits evenly, still the net x-momentum goes to zero in fluid, so same force. If the plate is angled, you'd resolve. Another scenario: a jet hitting a turbine blade (curved vane) that turns it by, say, 120°. If speed remains same (elastic collision assumption for fluid, not fully real but close if blade just redirects without much slowing), momentum change is large. In any case, you apply $\sum F = \dot{m}(V_{\text{out}} - V_{\text{in}})$ in vector form. These problems are usually plug-and-chug once set up, but conceptually, recognizing that *the force comes from momentum change* is key. Many students get thrown off by thinking about pressures – but if it's an open jet on a plate, pressures are atmospheric except at impact interface which you handle via momentum directly (no large static pressure buildup on a flat plate beyond the stagnation pressure which effectively is what provides the force, but we account it through momentum because $\dot{m}v$ already reflects that).

Finally, always remember to answer what's asked. If it asks "force on the object", give that (with proper direction). If it asks "force on the fluid", that's the opposite direction. The FE will usually frame it as force required to hold something or force exerted by fluid on a structure. So just be clear on action-reaction. A good habit: after computing, state to yourself: *The fluid is pushed this way, so the object is pushed the opposite way.* That will keep the signs straight.

By mastering these momentum applications, you'll handle those exam questions confidently. Not only will you crunch them correctly, but you'll also have physical intuition – so if you accidentally get a sign wrong in calculation, your intuition (like "the bend should push the fluid inwards, so the fluid pushes the bend outwards") can alert you to re-check. In my experience, developing that gut feeling for fluid forces is incredibly useful, and it starts with understanding these fundamental momentum examples.

Topic 04 - Internal Flow

Internal flow refers to fluid flow confined within conduits such as pipes and ducts. This topic is crucial for the FE Mechanical Exam because many engineering systems involve moving fluids through pipelines (think HVAC ducts, water supply lines, engine cooling loops). On exam day, you can expect questions asking you to calculate **pressure drop or head loss in a pipe**, determine the **friction factor** from flow conditions, evaluate **minor losses** from fittings, or apply **continuity and energy conservation** in a simple pipe network. By mastering internal flow, you'll quickly recognize which formulas to use – for example, knowing when to apply the **Darcy–Weisbach equation** for friction losses versus a minor loss coefficient for a valve – and you'll be adept at using the exam's reference handbook to find relevant data (like reading the Moody chart for friction factors). In short, internal flow problems typically boil down to understanding how **flow rate, pipe geometry, and surface roughness** produce frictional resistance, and how to account for additional losses or gains (like pumps) in a pipeline. The following subtopics break down the key principles and formulas you'll need, each with an easy-reference "passport" so you can confidently tackle the common exam question archetypes in this area.

K10.T04.S01 – Darcy–Weisbach Head Loss (Fully Developed Pipe Flow)

Principle Introduction: In a long, straight pipe with **fully developed, steady flow**, the primary energy loss is due to wall friction. The Darcy–Weisbach equation quantifies this **head loss** (energy loss per unit weight of fluid) caused by friction over a given pipe length. Key points to build intuition include:

- **Frictional resistance** increases with **length** and **flow velocity**, and decreases with a larger **pipe diameter** (less wall contact per flow area).
- The **Darcy friction factor** f captures how tough it is for the fluid to flow, depending on the flow's **Reynolds number** (laminar or turbulent) and the pipe's **relative roughness**.
- Fully developed flow means the velocity profile is established and doesn't change along the length – so the friction factor is constant for that segment and the formula applies uniformly.
- In design terms, Darcy–Weisbach helps determine how much **pressure drop** a pump must overcome to maintain a given flow rate through a pipe.
- Typical exam problems might give you flow rate, pipe size, and a material (for roughness) and ask for head loss (or vice versa), testing your ability to use this formula and related concepts correctly.

Equation Passport – Darcy–Weisbach Equation – *Computes the head loss due to friction in a pipe with steady, incompressible, fully developed flow.*

$$h_f = f \frac{L}{D} \frac{v^2}{2g}$$

Variables and Units:

- h_f – frictional head loss over the length L (meters of fluid, m; or feet of fluid, ft). This represents energy per weight lost, often expressed in length units.
- f – Darcy friction factor (dimensionless). A function of Reynolds number and relative roughness ($f = f(Re, \epsilon/D)$). **Note:** This is the Darcy (Moody) friction factor, *not* the Fanning f (which is 1/4 of the Darcy value) [^1].
- L – pipe length over which the pressure drop occurs (m or ft).
- D – inside diameter of the pipe (m or ft).
- v – average flow velocity in the pipe (m/s or ft/s). This is often obtained from Q/A where Q is volumetric flow rate and A is the cross-sectional area.
- g – acceleration due to gravity (9.81 m/s², or 32.17 ft/s² in US units).

Assumptions and Scope:

- **Steady, incompressible flow:** The fluid density is constant and conditions don't change with time. (No appreciable compressibility effects – valid for liquids and low-speed gas flow.)
- **Fully developed flow:** Enough distance from the pipe inlet so that the velocity profile is settled and does not change along L. Entrance effects are ignored[^2].
- **Round constant-diameter pipes:** Formula is derived for circular pipes. (For noncircular ducts, use the hydraulic diameter in place of D – see K10.T04.S04.)
- **Wall friction only:** Represents distributed friction loss along the pipe length. (Any valves or bends would add **minor losses** computed separately.)

Limit Checks (sanity tests):

- If **pipe length** $L \to \mathbf{0}$, then $h_f \to 0$. No length, no friction loss – sensible.
- If **flow velocity** $v \to \mathbf{0}$, then $h_f \to 0$. No flow, no losses.
- The dependence on v^2 means if flow speed doubles, friction loss *quadruples* – highlighting how sharply losses rise with faster flow.
- If friction factor f were zero (ideal perfectly smooth, no friction fluid), h_f would be zero – an ideal no-loss scenario. In reality f is never 0 for real fluids.

- **Use vs. Sibling Equations:** Use the Darcy–Weisbach equation for computing pressure loss or head loss in pipes for any fluid, given f. **Use this instead of** empirical formulas like Hazen–Williams when you need a general equation applicable to a variety of fluids and temperatures (Darcy–Weisbach works in both SI and USCS units as long as g is consistent). Also, use Darcy–Weisbach (plus minor losses) rather than Bernoulli's ideal equation when flow friction is non-negligible.

Common Exam Traps:

- **Units mix-ups:** Make sure to use consistent units. If using SI, $g = 9.81\ \mathrm{m/s^2}$ and h_f comes out in meters of

head. In US units, use $g = 32.17$ ft/s^2 so that h_f is in feet. *Do not plug in* $g = 9.81$ *if dimensions are in feet!* [^3]

- **Darcy vs. Fanning:** The exam handbook (Moody chart) uses the Darcy (Moody) friction factor. This f is about four times larger than the Fanning friction factor. Using the wrong one can underpredict or overpredict losses by a factor of 4[^1].
- **Incorrect v calculation:** Remember $v = Q/A$. Students sometimes plug in Q (flow rate) for v by mistake. Always convert flow rate to velocity using the pipe's area (e.g. for a 4-inch pipe, convert diameter to meters, find area $A = \pi D^2/4$, then $v = Q/A$).
- **Roughness in wrong units:** If you need to use relative roughness ϵ/D, ensure ϵ (absolute roughness) and D are in the *same units*. For instance, if D is in meters, express ϵ in meters as well.

Exam Handbook Search Cues (Not affiliated with or endorsed by NCEES): "head loss", "Darcy–Weisbach", "friction factor", "pressure drop in pipe"

Footnotes:

[^1]: *Darcy vs Fanning friction factor:* The Darcy–Weisbach friction factor f is the one used in the Moody chart and in this formula. The Fanning friction factor (often used in chemical engineering) is $f_{\text{Fanning}} = f_{\text{Darcy}}/4$. Ensure you use the Darcy form on the FE Exam (the exam handbook's chart explicitly labels f as Moody/Darcy).

[^2]: *Fully developed flow:* This assumes the initial developing region of the pipe (entrance length where the flow profile is still flattening) is separate. On the exam, if they want you to account for entrance effects, they would typically give a minor loss coefficient for the inlet – otherwise assume fully developed flow beyond a few diameters from the inlet.

[^3]: USCS unit consistency (g_c): In the head-loss form, do NOT include g_c: $h_f = f\left(\frac{L}{D}\right)\left(\frac{v^2}{2g}\right)$, with $g = 32.17$ ft/s^2, which gives h_f in ft. The g_c conversion constant is only needed when you compute pressure/force using lbm–lbf mixtures. For example, if ρ is in lbm/ft^3 and v is in ft/s, the pressure-drop form is: $\Delta p = f\left(\frac{L}{D}\right)\left(\frac{\rho v^2}{2g_c}\right)$, where $g_c = 32.17\ \frac{\text{lbm·ft}}{\text{lbf·s}^2}$ and Δp comes out in lbf/ft^2 (convert to psi by dividing by 144). Alternatively, avoid g_c by using specific weight γ in lbf/ft^3: $\Delta p = \gamma h_f$, with $\gamma = \frac{\rho g}{g_c}$.

- **Variations and Related Forms:** The Darcy–Weisbach equation can be rearranged to solve for pressure drop Δp instead of head: $\Delta p = \gamma\, h_f$, where γ is the fluid specific weight. So $\Delta p = f\frac{\left(\frac{L}{D}\right)(\rho\, v^2)}{2}$ in SI. In USCS, if ρ is in $\frac{lbm}{ft^3}$, use

$$\Delta p = f\frac{\left(\frac{L}{D}\right)(\rho\, v^2)}{2\, g_c}$$

  In laminar flow (low Reynolds number, $Re < 2300$), the friction factor has the simple formula $f = 64/Re$ (see **K10.T04.S02**), which can be plugged in to find h_f directly for laminar cases. Additionally, for quick estimates in turbulent flow, sometimes approximations or charts are used to find f; the Darcy formula itself remains the same. There is no dependency on pipe roughness in the formula explicitly – roughness influences f in turbulent flow, not the algebraic form of Darcy–Weisbach. Typical values: in turbulent flow, f often falls around 0.01–0.05 for common pipe sizes and flows (lower for smooth pipes at high Re, higher for rough pipes or lower Re). In laminar flow, f might be 0.016 at $Re = 4000$ (just into transitional) and climbs inversely with Re. These ranges help check if your f value from the Moody chart is reasonable.

- **Special Notes (calculator use):** The Darcy–Weisbach equation is straightforward to compute with a scientific calculator. Just be mindful of parentheses. For example, if you're solving for h_f, you'd type in sequence: f * (L / D) * (v^2 / (2 * 9.81)) in SI. If you need to find f given h_f, you might rearrange to $f = \frac{h_f 2gD}{Lv^2}$. The FE allowed calculators handle this arithmetic easily. There's typically no need for iterative calculation *in this formula itself* – the iteration comes in finding f for turbulent flow via the Colebrook equation, but on the exam you will use the Moody chart or be given f directly (they won't make you iterate with your calculator for Colebrook).

Explanation & Analysis: The Darcy–Weisbach equation is **the cornerstone formula** for internal flow problems involving pipes. It basically says: *the energy loss (per weight of fluid) due to friction* (h_f) is proportional to how "hard" it is for the fluid to move (encapsulated by f), how **far** it travels along the wall (L/D gives a measure of length relative to diameter), and how **fast** it's going ($v^2/(2g)$ is the kinetic head). Let's break it down term by term:

- f (friction factor): Physically, f accounts for the roughness of the pipe and the flow regime. A high f means the pipe or flow is causing a lot of friction (could be very rough pipe or turbulent, chaotic flow). A low f means smooth, easier flow (smooth pipe or laminar flow). For example, a brand-new smooth copper pipe has a lower f than an old rusty iron pipe at the same flow conditions. Also, laminar flow (well-ordered) has much less friction than turbulent flow (chaotic eddies) – hence the f formula for laminar being $64/Re$ which decreases as Re increases.

- $\frac{L}{D}$ (length/diameter ratio): This ratio shows that a longer pipe incurs more loss, and a wider pipe incurs less loss (since for the same flow, a bigger diameter means lower velocity and less wall contact per volume of fluid). Imagine pushing water through a **long straw** vs a **short straw** – the long straw is harder because friction accumulates over length. Likewise, pushing water through a **thin tube** vs a **wide pipe** – the thin tube offers more resistance because more of the fluid is scrubbing against walls in a confined space. The L/D term quantifies that geometry effect.

- $\frac{v^2}{2g}$ (velocity head): This term comes from kinetic energy. It's essentially the energy per weight of fluid associated with the flow velocity. The friction loss scales with the kinetic energy of the flow – faster flows have disproportionately higher energy losses (since it's v^2). If you quadruple the flow rate in a given pipe, velocity doubles (because $Q \propto v$ for fixed D), and the head loss actually quadruples (because v^2 term). This sharp

increase often surprises students – it's why **pushing a bit more flow** through a pipe can require a **much stronger pump**.

Using Darcy–Weisbach on the exam typically involves: (1) computing the velocity from a given flow rate, (2) looking up or calculating the friction factor f, and (3) plugging into the formula to find h_f. If asked for a pressure drop Δp, you multiply h_f by γ (fluid specific weight) or use $\Delta p = \rho g h_f$. Keep an eye on whether the problem gives you f directly (sometimes it will, especially if they don't want you to fuss with the Moody chart) or information to get it (Re, roughness). If a problem says **"neglect minor losses,"** it means use Darcy–Weisbach for the pipe and ignore any extra losses for fittings – just focus on this formula. By understanding each piece of Darcy–Weisbach, you'll also better understand how to reduce losses in real systems (e.g., use smoother pipes, larger diameters, shorter runs, or lower velocities to save pump energy). And on exam day, when you see a pipe flow question, Darcy–Weisbach should immediately pop to mind if friction or head loss is mentioned.

K10.T04.S02 – Friction Factor and Moody Chart (Laminar vs Turbulent Flow)

Principle Introduction: The **friction factor** f in the Darcy–Weisbach formula deserves special attention because it encapsulates the complex dependence on flow regime (laminar or turbulent) and pipe roughness. To determine f, engineers use the **Moody chart**, a famous graph plotting friction factor versus Reynolds number for various relative roughness values. Key intuition points include:

- **Reynolds number (Re)** governs flow regime: if Re is low (below ~2300 for pipes), flow is laminar and f can be calculated analytically ($f = 64/Re$ for Darcy's f). If Re is high (above ~4000–10000), flow is fully turbulent and f depends weakly on Re but strongly on pipe roughness. There's a transition zone in between where flow is neither fully laminar nor fully turbulent.
- **Relative roughness (ϵ/D)**: even a rough pipe can act hydraulically smooth at low Re (laminar flow doesn't "feel" roughness much). In turbulent flow, higher roughness bumps (ϵ) relative to diameter increase the friction factor. The Moody chart has separate curves for different ϵ/D – smooth pipes (like drawn tubing) have lower f in turbulent flow than rough pipes (like cast iron).
- The Moody chart is a **log-log plot**: Re on the x-axis (logarithmic), f on the y-axis (logarithmic). Laminar flow produces a straight line on this chart (because $f = 64/Re$ is a simple inverse relation). Turbulent flow produces curves that flatten out at high Re (approaching an asymptote equal to the **fully rough** friction factor where f no longer decreases with increasing Re).
- On the FE exam, you won't derive f from first principles – you'll either read it from the provided **Moody diagram** or apply known special cases. You should be comfortable identifying laminar vs turbulent from Re, using the laminar formula directly if applicable, or finding the appropriate curve on the Moody chart if turbulent.
- Typical question archetypes: given pipe diameter, flow rate, and roughness, find f (maybe then use it in Darcy–Weisbach). Or, given a described flow regime ("turbulent flow in a commercial steel pipe"), pick an estimated f. Or simply, identify whether flow is laminar or turbulent and apply the correct friction factor relation.

Diagram Passport – Moody Chart (Friction Factor Diagram) – *Graphical tool to determine the Darcy friction factor f for pipe flow given the Reynolds number and relative roughness.*

- **Axes and Quantities:** The Moody chart has **Reynolds number** on the horizontal axis (usually logarithmic scale, range ~10^3 to 10^8) and the **Darcy friction factor** f on the vertical axis (also log scale, roughly 0.01 to 0.1 range). The chart typically spans from the laminar regime through transitional to fully turbulent. **Re** increases to the right; f increases upward.

Key Regions and Curves:

- **Laminar region:** For $Re < 2000$ (approximately), the chart shows a straight line following $f = 64/Re$. In this region, roughness has negligible effect (all roughness curves converge to the same line). If the exam problem's Reynolds number falls here, you don't actually need the chart – just use $64/Re$.
- **Transitional region:** Roughly $2000 < Re < 4000$ (some sources say up to 10,000). The chart often shades this as a gray area or notes that it's "transitional" – flow is unstable. The friction factor in this zone is not given precisely on the chart because it can fluctuate. On the exam, you generally avoid doing detailed calculations in this regime; either flow is clearly laminar or clearly turbulent in well-posed problems. If Re lands in transition, either the problem will guide you or you use judgement (e.g., if $Re = 3000$ you might approximate using turbulent curve or laminar, but usually exam avoids ambiguity).
- **Turbulent region:** $Re > 4000$ up to 10^7 or beyond. Here, the chart shows multiple **curves** each corresponding to a **relative roughness** value (labelled by ϵ/D on the chart, e.g., 0.00001, 0.0001, 0.001, etc.). In turbulent flow:
    - For a **smooth pipe (low ϵ/D)**, the friction factor decreases as Re increases (higher $Re \rightarrow$ a bit less friction, until you reach extremely high Re where it levels off). The lowest curve on the left of the chart represents an "infinitely smooth" pipe (essentially friction factor due only to fluid viscosity, no roughness influence at moderate Re).
    - For **rough pipes (higher ϵ/D)**, the curves flatten out at a certain point – that flat portion is the **fully rough regime**, where increasing Re no longer lowers f because the roughness completely dominates the turbulence near the wall. The value of f at which it levels is higher for larger roughness. For example, a rough pipe might level off at $f = 0.03$ whereas a smoother pipe might level at $f = 0.012$.

- **How to Read It (exam-style):** Usually, you will know or compute: (1) the Reynolds number $Re = \frac{\rho v D}{\mu}$ (or equivalently $Re = \frac{vD}{\nu}$ using kinematic viscosity), and (2) the relative roughness ϵ/D (pipe roughness ϵ divided by diameter). **Reading steps:**

- **Locate the Reynolds number on the x-axis** – for example, $Re = 5 \times 10^5$.
- **Identify the curve** corresponding to the given relative roughness. If the problem says "commercial steel pipe" and provides $\epsilon = 0.045$ mm and $D = 50$ mm, compute $\epsilon/D = 0.045/50 = 0.0009$ (dimensionless). Find the curve labeled roughly 0.0009 (it might lie between the printed roughness lines if not exact). If roughness isn't given explicitly, sometimes it's implied (e.g., "smooth pipe" means use the smooth curve, essentially $\epsilon/D \to 0$).
- **Follow up from the Re value vertically until you meet the roughness curve**, then from that intersection, go horizontally to the y-axis to read off f. For instance, at $Re = 5 \times 10^5$ and $\epsilon/D = 0.0009$, you might hit an $f \approx 0.022$.
- If Re is in the laminar region, skip the chart: calculate $f = 64/Re$ directly (and double-check the question, as they may expect that quick calculation).

Common Misreads and Pitfalls:

- **Mixing up Darcy and Fanning:** The Moody chart on the exam is for Darcy f. Don't accidentally think a value like $f = 0.02$ is the Fanning factor. If a problem gives you a friction factor without specifying, assume Darcy unless they explicitly say otherwise.
- **Ignoring units for roughness:** Ensure the roughness ϵ is converted to the same units as diameter D before forming ϵ/D. (If D is in meters and they give ϵ in mm, convert mm to m.) The chart's roughness scale is dimensionless because of that ratio, but you must calculate it correctly.
- **Misaligning on log paper:** Reading a log-log plot can be tricky under pressure. Take care to find the correct decade for your Re and interpolate carefully between roughness curves. It's easy to accidentally read one curve for another if the lines are close – use a straightedge on the computer screen if needed to trace.
- **Not recognizing fully rough conditions:** At extremely high Re, if your operating point is in the flat part of a roughness curve, remember that further increases in Re won't change f much. A common mistake is thinking f keeps dropping with higher Re indefinitely – it doesn't for a rough pipe. Conversely, in a smooth pipe at moderate Re, students sometimes take a roughness curve that's not the lowest one, when in fact the flow is effectively smooth. If no roughness info is given, assume smooth pipe (use the lowest curve).

Exam Handbook Search Cues (Not affiliated with or endorsed by NCEES): "Moody chart", "friction factor f", "Reynolds number regimes", "relative roughness"

Footnotes:

[^4]: *Critical Reynolds number:* In the exam reference, flow is classified as **laminar** when $Re \lesssim 2100$and **turbulent** when $Re \gtrsim 4000$, with a **transition region** between these values. If you get a Reynolds number slightly above 2100, be cautious: the flow might be transitional. Usually, exam questions stick to well within laminar or well within turbulent to avoid ambiguity.

[^5]: *Relative roughness values:* Typical absolute roughness (ϵ) for new smooth pipes (copper, PVC) is on the order of 0.0015 mm to 0.01 mm, whereas rough concrete or rusty iron can be 1 mm or more. Relative roughness ϵ/D thus can range from near 0 (for a large diameter polished pipe) up to perhaps 0.01 (for a small, very rough pipe). For example, a commercial steel pipe might have $\epsilon \approx 0.045$ mm; in a 50 mm pipe that's $\epsilon/D = 9 \times 10^{-4}$ as used above. Knowing rough orders helps verify you chose the right curve on the chart.

Variations and Related Forms: Instead of the Moody chart, there are equations to compute f in turbulent flow, such as the **Colebrook–White equation** (implicit) or explicit approximations like the **Haaland equation**. For completeness: Colebrook–White is $\frac{1}{\sqrt{f}} = -2.0\log_{10}!\left(\frac{\epsilon/D}{3.7} + \frac{2.51}{Re\sqrt{f}}\right)$ – not something you'd solve by hand during the exam, but it underpins the chart. The Haaland formula (explicit) is $\frac{1}{\sqrt{f}} \approx -1.8\log_{10}![(\frac{\epsilon/D}{3.7})^{1.11} + \frac{6.9}{Re}]$. The FE Exam **does not expect you to memorize or derive these**, but if a problem says "using the Colebrook equation" they would give it to you. Generally, the chart or given f is the go-to. In laminar flow, note that $f = 64/Re$ is equivalent to another familiar result: the Hagen–Poiseuille law for pressure drop (which can be written $\Delta p = \frac{128\mu LQ}{\pi D^4}$). That's a variation when expressed in terms of flow rate Q. For turbulent flow, typical Darcy f values might be around 0.02 for smooth commercial steel at high Re, up to 0.05–0.08 for very rough pipes at lower Re. Recognizing if an answer choice is in a realistic range can sometimes help eliminate outliers.

Special Notes (calculator): Since reading the Moody chart is a visual task, one tip is to use the **search function in the exam's PDF handbook** – for instance, searching "Moody" will jump you to the chart page. Once there, use the on-screen tools (zoom, etc.) to read values carefully. The allowed calculators won't help solve Colebrook directly (no algebraic solver allowed), so rely on the chart. If needed, you can interpolate roughly between curves: for example, if ϵ/D is between two plotted curves, f will be between their values. But the exam often provides an ϵ/D that matches a line or expects a coarse reading (within maybe ±10% error). Don't overthink precision – if you read $f \approx 0.02$, that's usually enough unless options are very close.

Explanation & Analysis: The **Moody chart** is essentially a map of how "sticky" or "resistive" a pipe flow is under different conditions. The friction factor f is high when flows are **laminar** (at really low Re, fluid sticks in layers and paradoxically that creates high resistance relative to inertia) – as Re increases in laminar regime, inertia starts to overcome viscosity, so f drops inversely. Once turbulence kicks in, adding more speed (higher Re) can initially still reduce f (because the chaotic mixing actually distributes momentum and can reduce wall shear stress relative to inertia a bit), but if the pipe wall is rough, at some point the size of those roughness elements dominates the flow near the wall. Then no matter how high Re goes, those rough bumps keep creating vortices and drag, setting a floor on f.

Imagine water flowing through two pipes at the same Reynolds number: one is smooth plastic, the other is old cast iron with barnacles. In the turbulent regime, the cast iron's roughness causes swirling eddies and energy loss, so its friction factor f is higher than that of the smooth pipe. The Moody chart quantifies this difference.

For exam analysis: if you compute Re and find, say, $Re = 500{,}000$ (definitely turbulent) and the pipe is "smooth", you'd slide your finger to roughly the bottom of the chart near 5×10^5 and maybe get $f \approx 0.018$. If instead the pipe was "rusty" with $\epsilon/D = 0.002$, you'd be on a higher curve, maybe $f \approx 0.03$ at the same Re. That difference could mean a pressure drop twice as high in the rough

pipe for the same flow. Recognizing laminar vs turbulent quickly is crucial: **Laminar** → use $f = 64/Re$ without fuss; **Turbulent** → go to chart. And if the problem statement hints "smooth pipe" or gives a roughness, use that info accordingly. One analytical clue: laminar flows are usually associated with slow, viscous conditions (like oil flowing slowly, or very small diameter channels), whereas turbulent flows are the norm for water in standard industrial pipe sizes at moderate to high flow rates. So if you see water at 2 m/s in a 4-inch pipe, you can bet it's turbulent (Re on the order of 10^5).

In summary, mastering the friction factor means mastering the Moody chart or its correlations. It's an essential step in any pipe head loss problem, and the FE exam will often test your ability to correctly obtain and use f. Practice a couple of readings from the chart before the exam so you're comfortable with the log scales. And always double-check: does the f you found make sense? (For example, f should never be greater than 1 or crazy low like 0.0001 in the ranges we deal with. An f around 0.02–0.05 is common for turbulent flow, and if laminar at $Re = 1000$, $f = 0.064$.) A wildly off f might mean you misread the chart by a decade. So use your engineering judgment as a safety net.

K10.T04.S03 – Minor Losses in Pipes (Valves, Bends, Fittings)

Principle Introduction: Not all the energy loss in a pipeline comes from long straight friction – bends, valves, tees, and other fittings cause additional *localized* losses, known as **minor losses**. While called "minor," they can actually accumulate to be significant (especially if you have many fittings). Each such component is characterized by a **loss coefficient**, often denoted K (or sometimes C in certain references [^6]). This coefficient multiplies the velocity head to give the head loss due to that component. Intuition and key points:

- **Physical origin:** Minor losses come from flow separation, eddies, and turbulence as fluid navigates a sudden geometry change – e.g., turning a corner (elbow), passing through a partly closed valve, or expanding into a larger pipe. These cause extra dissipation of energy.
- **Superposition:** Minor losses are typically additive. If you have several fittings in series, you sum up all the $K(v^2/2g)$ terms for each to get total minor head loss. They add to the Darcy friction loss to give total head loss.
- **Relative scale:** A gentle, well-shaped bend might have a small K (say 0.2), whereas a sharp 90° elbow or a fully open gate valve might have a moderate K (~0.3–0.5). A partially closed valve can have a very large K (5 or 10 if nearly closed). An extreme case: a dead-end or closed valve is like an infinite K (flow stops). The exam may provide typical K values if needed, or state "minor losses account for X meters of head" directly.
- **Velocity reference:** Importantly, the velocity v used in $K\left(v^2/(2g)\right)$ should correspond to the section of pipe where that fitting is. If the pipe diameter is constant throughout (common case), just use the main flow velocity. If there's a sudden expansion or contraction, there are specific K formulas or values for those based on the upstream or downstream velocity – but the exam might supply those or use an equivalent K. (For instance, a sudden expansion has $K = (1 - !A_{\text{ratio}})^2$ based on area change – but don't worry unless a problem specifically brings it up.)
- Typical exam questions might give you a list of components (e.g., "two elbows ($K = 0.3$ each) and a globe valve ($K = 10$) in a 100 ft pipe") and ask for total head loss. You'd calculate Darcy h_f for the 100 ft and add the minor losses $= (0.3 + 0.3 + 10)\left(v^2/(2g)\right)$.

Equation Passport – Minor Loss (Local Head Loss) – *Computes head loss due to a pipe fitting, valve, bend, or other local disturbance using a loss coefficient.*

$$h_m = K\,\frac{v^2}{2g}$$

Variables and Units:

- h_m – head loss due to the specific "minor" component (m or ft of fluid). Sometimes denoted h_L or h_{loss} for a fitting. It has the same units as h_f and represents energy per weight lost at that location.
- K – loss coefficient for that component (dimensionless). Each fitting/valve type has its own K (empirically determined). It essentially says how many velocity-head units are lost. For example, $K = 1.5$ means the loss is $1.5 \times$ the kinetic energy per weight of the flow.
- v – flow velocity in the pipe at the fitting (m/s or ft/s). If the fitting is in a constant-diameter pipe run, use the same average velocity as in that pipe. If it's a sudden expansion or contraction, typically the loss is referenced to one side's velocity (the problem will specify or provide an effective K).
- g – acceleration due to gravity (9.81 m/s² or 32.17 ft/s², as usual).

Assumptions and Scope:

- Assumes **incompressible flow** and that the loss is local to the component (downstream of it the flow recovers to a normal distribution). These losses are experimentally determined and inherently account for the complex flow separations.
- **Single-phase fluid** (no weird multiphase effects) and usually valid for a range of turbulent flow conditions. In laminar flow, minor loss coefficients might differ slightly, but most pipe networks in practice run turbulent where these K values apply consistently.
- The components are typically reported as **fully open** (for valves) unless stated otherwise. A partially closed valve would have a different (usually larger) K. The exam will specify if, say, a valve is half-open and give a K for that scenario.
- Minor losses are considered "minor" in the sense of being localized, not necessarily negligible. So we treat them separately from the length-dependent Darcy friction.

Limit Tests:

- If $K = 0$, $h_m = 0$ – meaning a perfectly streamlined component that introduces no extra loss (like a straight section of pipe has effectively $K = 0$ aside from its friction which is accounted separately). No real fitting has zero loss except perhaps an *ideal* gradual diffuser or something extremely well streamlined.
- If velocity $v \to 0$, $h_m \to 0$. No flow, no loss – consistent with intuition.
- If you had an extremely large K (approaching infinity), that would imply a huge loss – e.g., a closed valve creates

an infinite resistance, essentially stopping flow (which indeed would require infinite head to push any flow through). So practically, large K means that component throttles the flow a lot.

Use vs. Sibling Equations: Use $h_m = K\frac{v^2}{2g}$ for individual concentrated losses *instead of* trying to approximate them with an equivalent pipe length in Darcy's formula (though sometimes you'll hear of an "equivalent length L_e" where they say an elbow's loss is like adding so many feet of pipe – that's a derived concept: $L_e = K\frac{D}{f}$ for that fitting to produce the same h_f). The exam might mention equivalent length, but more commonly it sticks to K values directly. Also, **use this formula in addition to Darcy–Weisbach** when a problem includes fittings – total head loss = h_f(pipe) + $\sum h_m$(fittings). The Bernoulli equation with a pump would include both distributed (h_f) and minor (h_m) losses on the losses side.

Common Exam Traps:

- **Forgetting to sum all losses:** If multiple fittings are present, each one contributes. A classic mistake is to compute one h_m and treat it as the total – remember to add them up. For example, two elbows each with $K = 0.2$ give total elbow loss $0.4\,\frac{v^2}{2g}$.
- **Confusing K with f or mixing forms:** K is not the same as the friction factor f in Darcy–Weisbach. f goes with L/D and accounts for many pipe diameters of friction, whereas K is a one-shot number for a fitting. If a problem statement lists both f and some K's, use f in the Darcy formula for pipe sections and K in the minor loss formula. Don't plug K into Darcy–Weisbach or vice versa.
- **Applying wrong velocity:** Ensure that v in each $K(v^2/2g)$ term corresponds to the correct cross-section. E.g., if a pipe expands from 2" to 4" and you have a sudden expansion loss, the loss formula might be referenced to the smaller pipe's velocity (since that's where the big disruption happens). The exam will usually clarify, or you can derive if needed (but generally they keep it straightforward). In most cases with constant diameter, this isn't an issue – use the same v as for Darcy in that pipe.
- **Units consistency:** Minor loss coefficients K are dimensionless, so no unit issues there. Just be sure $v^2/(2g)$ yields length units of head. If v is in ft/s and using $g = 32.17$ ft/s^2, then $v^2/(2g)$ is in feet. If v is in m/s with $g = 9.81$, $v^2/(2g)$ is in meters. If the problem gives head loss in, say, feet but your v was in m/s, convert units appropriately.

Exam Handbook Search Cues (Not affiliated with or endorsed by NCEES): "minor loss", "loss coefficient K", "fittings head loss", "K (v^2/2g)"

Footnotes:

[^6]: *Notation:* The FE Reference Handbook uses C for loss coefficient in the fluids section (e.g., $h_{f,\text{fitting}} = C\left(v^2/(2g)\right)$). Many textbooks use K. They mean the same thing – just different letters. Don't let that confuse you: if you see C or K associated with a fitting, treat it as the loss coefficient. (In the context of pump/minor losses, C is *not* the Hazen-Williams roughness here – it's a local loss factor. Always interpret by context.)

Variations and Typical Values: Some typical K values (just for context, you don't memorize but might recognize):

- 90° smooth elbow: $K \approx 0.3$ (sharp elbow could be higher, threaded 90° might be ~1.5)
- Fully open gate valve: $K \approx 0.15$ (a gate valve has very little obstruction when open)
- Fully open globe valve: $K \approx 10$ (globe valves are very restrictive even when open, hence a much larger loss)
- Sudden contraction: K around 0.4 (depends on area ratio)
- Sudden expansion: K could be as high as 1.0 (a lot of turbulence when expanding abruptly)
- Entrance from a large tank to a pipe (sharp-edged inlet): $K \approx 0.5$; Exit from pipe to reservoir: $K \approx 1.0$ (these values account for converting kinetic energy to heat as flow either accelerates into a pipe or dissipates out into a tank).

On the exam, if they want a specific value, they will either give it or use a well-known one (like 0.5 for entrance, 1.0 for exit). Remember you can sum them: e.g., pipe intake (0.5) + pipe exit (1.0) together would contribute $1.5\,\frac{v^2}{2g}$ in total minor losses for those two transitions. If a problem statement doesn't provide K explicitly but mentions a "minor loss at the exit", you're expected to know an open pipe discharge to a reservoir is about one velocity head ($K = 1$ loss).

Special Notes (calculator and approach): There's no special calculator trick here – just add up the terms. However, a strategic point: sometimes rather than calculating each minor loss one by one, you might lump them. For example, "total K for all fittings = 1.2" then $h_{m,\text{total}} = 1.2\,\frac{v^2}{2g}$. If the exam problem lists several K's, feel free to sum them before multiplying by $v^2/(2g)$. That reduces chances of arithmetic error. If working in US units, you might compute $v^2/(2g)$ in ft, then multiply by the sum of K. Keep track if you're asked for head loss (a length) vs pressure loss – if pressure in psi is needed, you'd convert using 1 psi = 2.31 ft of water (approx) or use $\Delta p = \gamma h$. Usually they stick to head or give γ to convert.

Explanation & Analysis: Minor losses complete the picture of internal flow by accounting for all those "extra" energy losses that Darcy–Weisbach alone doesn't cover. When fluid flows through an elbow, it has to change direction – inertia makes it want to keep going straight, so it pushes on the outer wall of the elbow, creating recirculation zones and energy dissipation. A valve partially blocks the flow, causing a big pressure drop as fluid squeezes through and then expands again, generating lots of turbulence (which is energy lost as heat).

In analysis, you simply treat each fitting's loss as an independent additive contribution. For example, say water (at some velocity v) goes through two elbows and one open globe valve before discharging. Each elbow might lose, say, $0.3\,\frac{v^2}{2g}$ and the globe loses $10\,\frac{v^2}{2g}$. So total minor loss = $(0.3 + 0.3 + 10)\frac{v^2}{2g} = 10.6\,\frac{v^2}{2g}$. If $v^2/(2g)$ was, say, 4 m (meaning the kinetic head is 4 m), then minor losses sum to $10.6 * 4 = 42.4$ m. That's substantial! Meanwhile the straight pipe friction $h_f = f\,\frac{L}{D}\frac{v^2}{2g}$ might be, for example, 20 m. So in this case, the so-called "minor" losses actually exceeded the straight friction losses – this can happen

especially with restrictive valves. So always check if minor losses are significant in the problem; don't neglect them unless instructed.

Another analytical insight: sometimes a problem might ask *qualitatively* what reduces minor losses – the answer is usually using more streamlined fittings (like long-radius elbows vs sharp elbows, or gradually enlarging pipes rather than sudden expansions). But quantitatively, you'll plug numbers. The important thing is consistency: use the same velocity for all losses in the same pipe run, and add them with the friction loss. If you then plug into Bernoulli or energy equation, the total loss (friction + minors) goes on the losses side. If a pump is present, it must overcome both.

In summary, handle minor losses methodically: list out all given K values, sum them (if the flow through them is in the same section with same v), multiply by $v^2/(2g)$. If there are different velocities (like different pipe diameters in series), compute h_m for each section with its respective velocity. The FE exam typically keeps one diameter for simplicity in these calculations, but be mindful if there's a change. After doing a couple of these, you'll see it's straightforward – just don't drop any terms and you'll be good.

K10.T04.S04 – Hydraulic Diameter for Noncircular Conduits

Principle Introduction: The equations and concepts we use for pipe flow (Darcy–Weisbach, Reynolds number, etc.) are derived assuming a circular pipe with diameter D. But what if you have a **noncircular duct or channel** (like a rectangular air duct, or an annulus between two pipes)? Enter the **hydraulic diameter** D_h. This is a clever way to convert any closed cross-section into an equivalent diameter so you can plug into the same formulas. Key points:

- **Definition:** Hydraulic diameter is defined as $D_h = \frac{4A}{P}$, where A is the cross-sectional flow **area** and P is the **wetted perimeter** (the portion of the perimeter in contact with the fluid). For a circular pipe, $A = \pi D^2/4$ and $P = \pi D$, so $D_h = \frac{4(\pi D^2/4)}{\pi D} = D$. It gives the same diameter, as expected. For noncircles, it provides a single length scale to use in Reynolds number and friction factor calculations.
- **Usage:** Use D_h in place of D when computing Reynolds number $Re = \frac{vD_h}{\nu}$ and when using the Darcy–Weisbach or other relationships. Essentially, treat the noncircular duct "as if" it were a round pipe of diameter D_h. This works reasonably well for fully enclosed flows. (Do not confuse this with open-channel flow hydraulic radius – that's a related concept but for open channels where the top is free surface).
- **Examples:** For a **rectangular duct** of width W and height H (flow full of course), $A = W \times H$ and $P = 2(W + H)$ (all sides wet). So $D_h = \frac{4WH}{2(W+H)} = \frac{2WH}{W+H}$. If $W = H$ (a square duct), $D_h = \frac{2W^2}{2W} = W$ – the hydraulic diameter equals the side length for a square (makes sense by symmetry with a circular analogy). If one side is much larger than the other ($W \gg H$), then $D_h \approx \frac{2WH}{W}$ (since $W + H \approx W$) $= 2H$ – interestingly, in a very flat duct, the hydraulic diameter is about twice the smaller dimension (height), reflecting that the flow is like between two parallel plates.
- **Limitations:** Hydraulic diameter is a useful approximation but assumes flow distributes evenly. It works well for fully turbulent flow in noncircular closed conduits. For laminar flow in noncircular shapes, you might need specific formulas for friction factor (like for flow between parallel plates, etc., though often those still use D_h with corrected constants). For the FE exam, using D_h is the expected method unless they explicitly give another formula.
- **Annulus (the space between concentric pipes):** Here $A = \frac{\pi}{4}\left(D_{\text{outer}}^2 - D_{\text{inner}}^2\right)$ and $P = \pi(D_{\text{outer}} + D_{\text{inner}})$ (both inner and outer surfaces are wetted). Plugging in, $D_h = \frac{4\times\frac{\pi}{4}(D_o^2 - D_i^2)}{\pi(D_o + D_i)} = \frac{D_o^2 - D_i^2}{D_o + D_i} = D_o - D_i$. Neat result: the hydraulic diameter of an annular channel is simply the difference in diameters (outer minus inner). Good to remember if you get an annulus problem.
- The exam might directly ask for hydraulic diameter given dimensions, or might embed it in a larger problem (e.g., "air flows through a 1 m by 0.5 m rectangular duct – calculate the Reynolds number" → you should compute $D_h = 210.5/(1 + 0.5) = 0.67$ m first). So be ready to compute D_h and then proceed as if it's a normal pipe problem.

Equation Passport – Hydraulic Diameter – *Defines an equivalent circular diameter for a fully enclosed noncircular flow conduit, so standard pipe flow formulas can be applied.*

$$D_h = \frac{4A}{P}$$

Variables and Units:

- D_h – hydraulic diameter (m or ft). The effective diameter for flow calculations. It has units of length.
- A – cross-sectional area of flow (m² or ft²). This is the area through which fluid flows. For complex shapes, make sure this is the area of the wetted cross-section.
- P – wetted perimeter of the cross-section (m or ft). This is the length of the boundary that is in contact with the fluid. In a fully filled duct, it's the entire inner perimeter. (Exclude any sides that are not touching fluid – for a completely full closed conduit, that's all sides. If we were dealing with a partially filled channel, P would only be the wet part, but that's open-channel context.)

Assumptions and Scope:

- Applies to **fully filled** ducts or conduits of arbitrary shape, for internal flows. If the conduit is not running full (like half-pipe flow), that falls under open-channel flow analysis, not this formula.
- Assumes a single cross-section shape is consistent along the flow's length. If the duct changes shape, you might compute different D_h for different segments.
- It's an empirical concept – it allows noncircular flows to be treated in formulas derived for circles. Generally accurate for turbulent flows. For laminar, it still works for computing Re and classifying flow, but some laminar solutions (like exact velocity profiles) would differ by geometry. For FE exam purposes, use it universally for internal flow formulas unless told otherwise.
- **No distinction of sides:** D_h doesn't tell you the aspect ratio of the shape, just one number. Two different shapes can have the same D_h. So, two ducts with equal hydraulic diameter will behave similarly in terms of pressure drop

if flow conditions (Re, roughness) are similar, despite different shape, as long as flow is fully developed turbulent. This is the idea behind it.

Limit Checks:

- For a circular pipe: $A = \pi D^2/4$, $P = \pi D \Longrightarrow D_h = \frac{4(\pi D^2/4)}{\pi D} = D$. Good, it recovers the actual diameter.
- For a very tall, skinny rectangle (like height H, width $W \to \infty$), $A \approx W \times H$, $P \approx 2W + 2H \approx 2W$ (dominant), so $D_h \approx \frac{4WH}{2W} = 2H$. That matches intuition: flow between two infinite parallel plates (gap H) has $D_h = 2H$. This is a known result.
- If area A is fixed but perimeter P increases (meaning the shape becomes more elongated or irregular), D_h decreases. This signals that more perimeter (more wall contact) for the same area makes the effective diameter smaller – i.e., more frictional interaction relative to cross-section, which seems right.

- **Use vs. Sibling Concepts:** Use D_h in formulas like Reynolds number and Darcy–Weisbach whenever you have a non-round conduit. Do **not** use hydraulic diameter for open channel flow situations – there, a related idea is the **hydraulic radius** $R_H = A/P$, which is actually $D_h/4$ by definition. Open channel flows (partially filled) are handled with different equations (Manning's etc.), not Darcy–Weisbach with D_h (unless specifically told to, but that's rare). In closed conduits under pressure, D_h is your friend.

Common Exam Traps:

- **Using the wrong perimeter:** The wetted perimeter P is *only* the portion in contact with fluid. In a full pipe or duct, that's the whole inner perimeter. If a problem ever gave, say, a half-pipe with air on top, the wetted perimeter would exclude the open top. But for "internal flow" we assume full. Just be careful: sometimes a rectangular "duct" might have one side that's a different material, but as long as fluid touches it, count it.
- **Arithmetic errors computing A or P:** It sounds simple, but under stress it's easy to make a mistake. For example, for an annulus: forgetting to subtract inner area, or messing up perimeter by using circumference formulas incorrectly. Write down formulas: for rectangle $A = WH$, $P = 2(W + H)$; for annulus $A = \pi\left(D_o^2 - D_i^2\right)/4$, $P = \pi(D_o + D_i)$. Have those clear.
- **Confusing D_h with something else:** Don't plug D_h into formulas where raw D was not intended. Actually, scratch that – you should plug it into essentially all the standard internal flow formulas. The trap might be if someone forgets and uses the actual width or something in Re. Another trap: If the reference handbook lists some formula like $f = 64/Re$ for laminar, that Re must use D_h if it's not a circular pipe. So it's implicit but worth remembering.
- **Checking consistency:** After computing D_h, treat the problem like a normal pipe of diameter D_h. But if the problem provides a roughness value, is it for the actual surface? Yes – use the actual roughness of that surface for ϵ, and still divide by D_h for relative roughness. E.g., a 2 m by 1 m concrete duct: maybe $\epsilon = 3$ mm for concrete, $D_h = 1.33$ m, so $\epsilon/D_h = 0.003/1.33 = 0.0023$. Then find f from Moody using that. So don't forget to use D_h in roughness ratio as well.

Exam Handbook Search Cues (Not affiliated with or endorsed by NCEES): "hydraulic diameter", "noncircular conduit", "hydraulic radius", "4A/P"

Footnotes:

[^7]: *Hydraulic radius vs diameter:* You might see $R_H = A/P$ termed hydraulic radius (especially in Civil engineering context or open channels). Note that $D_h = 4R_H$. For closed full flow, R_H is just $D/4$ for a circle. For open channels, Manning's equation uses R_H. For the FE Mechanical, stick to D_h for internal flow problems. If you accidentally use R_H in place of D_h in the Reynolds number, you'd under-calculate it by factor 4 – so make sure to use four times the hydraulic radius (which is D_h) when needed.

[^8]: *When shapes get complex:* If a cross-section isn't simply described, D_h still works as long as you can find area and perimeter. For example, an equilateral triangle duct – you can compute its area ($A = \frac{\sqrt{3}}{4}a^2$ for side a) and perimeter ($3a$), then $D_h = \frac{4A}{P}$. The formulas aren't in the handbook for every shape, but area/perimeter formulas are often known or given.

Variations and Examples: We already mentioned the annulus example ($D_h = D_o - D_i$). Another one: **Circular pipe half filled** – that's open channel, but to illustrate, there A is half the circle area, P is half the circumference (wet half) plus the width of the surface if you considered friction with air negligible (which it often is, so wetted P is half circumference). If you plugged that in, you'd get D_h equal to the diameter (surprise: half-full circular pipe has hydraulic diameter the same as full pipe for water – but this is coincidence of shape symmetry). The point: be careful distinguishing internal vs open flow. For **noncircular closed** cases you might encounter: rectangular ducts (common in HVAC), annuli (common in double-pipe heat exchangers or coaxial pipes), or maybe triangular or semi-circular ducts (less common, but possible in some manufacturing contexts). All are fair game for D_h. Typically, once you compute D_h, you'll go on to calculate $Re = \frac{\rho v D_h}{\mu}$ and perhaps find friction factor or head loss. The head loss formula can be written $h_f = f\frac{L}{D_h}\frac{v^2}{2g}$ for noncircular using D_h. And it works – the friction factor correlations (Moody chart) were developed such that using D_h gives equivalent results for pressure drop in different shapes experimentally.

Special Notes: There's generally no additional calculator concerns – computing area and perimeter might involve remembering some geometry. If a problem provides dimensions in say cm, convert to meters if you're going to compute things in SI (to use standard $g = 9.81$ in m/s² and get head in m). Also, be aware of edge cases: if a duct is extremely thin in one dimension, D_h becomes small, indicating high friction for a given area – that aligns with experience, e.g., flow in a thin slot (two parallel plates) has more resistance than in a round pipe of equivalent cross-section area. Hydraulic diameter captures that.

Explanation & Analysis: Hydraulic diameter is a convenience that says: **"whatever the shape, I can compare it to a round pipe."** The factor $4A/P$ comes from rearranging the Darcy–Weisbach formula and Poiseuille's law forms to make them analogous. Intuitively, A/P (hydraulic radius) is like a cross-section-to-wall

ratio – bigger area or less perimeter gives easier flow (bigger effective diameter).

Let's analyze a scenario: Air flows through a 1 m × 0.5 m rectangular duct at a certain velocity. We find $D_h = 2(1 * 0.5)/(1 + 0.5) = 0.67$ m. Now, imagine instead a round pipe of 0.67 m diameter carrying air at that velocity. The frictional behavior (pressure drop per length, etc.) should be similar between the two cases. If the question asks for Reynolds number: we use D_h in Re. This Re tells us if flow is turbulent or laminar just as reliably as if it were an actual diameter. If Re comes out high and we need a friction factor, we'd go to the Moody chart with ϵ/D_h etc. For the duct, maybe they give a roughness equivalent (e.g., galvanized sheet metal roughness ~0.09 mm). Then ϵ/D_h for 0.67 m is 1.3×10^{-4}. We'd treat that like a moderately smooth pipe.

Essentially, hydraulic diameter allows us not to reinvent new charts or formulas for each shape. It's remarkably effective for engineering work. For fully turbulent flow, the velocity profile shape differences matter less, so D_h works great. For laminar, if ever needed, one caution: the laminar friction factor formula $64/Re$ technically is for circular tubes, but if using D_h, it gives a decent approximation for other shapes too. The exam probably won't split hairs on that; if it's laminar in a duct, use $64/Re$ with Re based on D_h. If it's an annulus laminar, maybe not straightforward unless they gave you something, but typically FE doesn't dive that deep.

One more insight: If two shapes have the same A and same P, they have the same D_h and presumably similar flow resistance characteristics. For example, a 1 m diameter round pipe and a 0.5 m by 1.5 m rectangle might coincidentally have similar $4A/P$ (just a hypothetical). It means they'd exhibit similar friction factors at same Re. That's useful when designing ductwork – you can use pipe flow data for rectangular ducts via D_h.

In conclusion, remember this subtopic whenever you see a **non-round shape** in a fluids problem. Immediately think: compute A, compute P, get D_h. Then proceed as normal. It's usually a quick calculation but crucial step.

K10.T04.S05 – Pipe Network Basics (Series, Parallel, and Pump Head)

Principle Introduction: Real systems often have multiple pipes connected in networks – with splits (parallel paths) and joins, and pumps adding energy. Solving pipe networks rigorously can be complex, but the FE Mechanical Exam typically focuses on the fundamental principles that govern them: **continuity of flow** (mass conservation) and **energy conservation** (often via an extended Bernoulli equation including head losses and pump head). Key conceptual points:

- **Continuity at junctions (flow splitting or joining):** The total flow into a junction equals the total flow out (for incompressible fluids, essentially volume flow rate conservation). For example, if a pipe splits into two branches, $Q_{\text{in}} = Q_1 + Q_2$ for flows in the branches. If two branches recombine, $Q_{\text{out}} = Q_1 + Q_2$ merging into it. No fluid is lost or gained at the junction (assuming no storage or leak), analogous to current splitting in an electrical circuit node.
- **Energy balance around loops (and including pumps):** If you start at one point in a network and follow a closed loop back to that point, the net energy change is zero. In practice, this means: **Sum of head gains (from pumps) = Sum of head losses (from friction + minor losses) + any elevation rises** around that loop. This is analogous to Kirchhoff's voltage law in circuits. For a simpler case of a single pipeline with a pump: the pump head must equal the total head loss plus any difference in potential (height) and pressure between the start and end points.
- **Pipes in series:** When pipes are connected one after another (same flow through each), the **flow rate Q is the same** in all (like current in series), and the **head losses add up**. So if you have a 50 m pipe then a 100 m pipe (same diameter maybe) in series, total $h_f = h_{f1} + h_{f2}$. If diameters differ, the flow is still same but you'd compute each segment's loss with its own f, L, D, v etc. Pressure drops add accordingly. Essentially: series = **constant flow, additive head loss**.
- **Pipes in parallel:** When flow splits into two (or more) parallel paths and then reunites, **the head loss over each path is the same** (because they start and end at the same points energetically). However, the flow divides such that the one with less resistance carries more flow. So you use: $Q_{\text{total}} = Q_A + Q_B$, and impose that $h_{f,A} = h_{f,B}$ between the split and reunion points (assuming they reconverge at the same downstream pressure/elevation). Practically, this means the branch with larger diameter or shorter length will have a smaller friction factor or shorter path, so it gets a larger portion of Q until its head loss matches the other. The exam might not ask you to solve the exact split via iteration, but conceptually you should know equal head drop in parallel.
- **Pump head and pump curve:** In network basics, know that a pump provides a **head rise** (energy addition) to the fluid. If a pump is in series with the pipes, the pump's head (often given by a curve relating head to flow) must equal the losses to achieve steady flow. The operating point is where pump head = system head loss. The exam might give a pump curve equation or a fixed pump head and ask for flow, or vice versa. Or simply ask what happens if you put pumps in series or parallel:

  Pumps in series: heads add (like batteries in series increase voltage) – you get more head at a given flow.

  Pumps in parallel: flow capacities add at the same head (like parallel current sources) – you can push more flow at a given head.
- **Energy (Bernoulli) with losses:** The extended Bernoulli equation for two points (1 and 2) in a network with a pump can be written as:

  $$\frac{p_1}{\gamma} + z_1 + \frac{v_1^2}{2g} + h_{\text{pump}} = \frac{p_2}{\gamma} + z_2 + \frac{v_2^2}{2g} + h_f + h_m,$$

  where h_{pump} is the head added by pump(s) between 1 and 2 (if flow goes through a pump), and h_f, h_m are the friction and minor losses between 1 and 2. This is a more general energy balance that you can trim down depending on what's in your situation (for instance, if 1 and 2 are both reservoirs open to atmosphere, p_1/γ and p_2/γ are zero gauge; if velocities are negligible in big tanks, those terms drop, etc.). The exam often simplifies this to: *Pump head = head losses + elevation gain*. That's a common case: pumping water up to a tank: pump must overcome both the friction losses in pipe and the static lift.

  So in summary, solving a network problem means writing continuity equations for flow splits and Bernoulli/energy equations for loops or paths, then solving for unknown flows or heads. The FE exam will likely keep things to one or two equations at most (not a giant system).

Definition/Note Passport – Pipe Network Analysis Principles
- Plain-language definition: *Pipe network analysis* uses conservation laws to determine flow rates and pressure drops in interconnected pipe systems. In essence: **mass is conserved at each junction** (no fluid accumulation, so inflow = outflow for that node), and **energy is conserved around each loop or path** (accounting for added pump energy and subtracted losses). These principles ensure every part of the network is consistent with the rest (no magic creation of fluid or energy).

- **Where it matters (exam impact):** You'll see this in questions about combined piping systems – for example, two pipes in parallel between the same reservoirs, or a fire hydrant system where water can take multiple paths. It also appears when a pump is added: you must relate the pump's head to the needed head to push fluid through pipes. A typical exam question might ask: "Given two parallel pipes between A and B, and flows Q_1, Q_2 in each, if Q_{total} is known (or a pressure drop is known), find the flow in each branch." Or, "How much head must a pump provide to deliver a certain flow through a pipeline with known losses?" Another could be conceptual: "Pumps in series vs parallel – which increases flow vs which increases head?" Understanding network basics equips you to answer all of these.

- **Pitfall or confusion point:** One common misunderstanding is mixing up series and parallel conditions. **Series**: students sometimes forget the flows are equal and instead erroneously add flows; remember, in series there's only one path – what goes in must come out the other end unchanged (assuming no leaks). **Parallel**: conversely, students might set the pressures equal incorrectly or assume flows equal – in parallel, generally flows are *not* equal (unless pipes coincidentally have same resistance); what's equal is the **head loss** across each branch (because both branches connect the same nodes). Another pitfall: not accounting for a pump correctly in Bernoulli – e.g. forgetting to add the pump head on the left side of the equation, or putting it on the wrong side (if you treat pump as a "drop" instead of a "rise" incorrectly). Sign conventions matter: pump adds head (positive), turbine would remove head (negative contribution). Also, confusion can arise in units: ensuring you convert everything to head (meters or feet) consistently. For instance, if pressure is given in psi, convert to feet of head by p/γ before plugging into Bernoulli with h_f in feet.

- **Micro-check:** *True/False:* In a pipe network with two parallel branches, the branch with lower resistance will carry a higher fraction of the total flow. **(True.)** – This quick mental check reminds you how parallel flow distributes. Or another: *Quick estimate:* If one branch is twice as long as another identical branch in parallel, roughly how will flows split? (Answer: the shorter branch will carry about $\sqrt{2}$ times the flow of the longer, because head loss scales with Q^2 for given pipe, so for equal head loss you get $Q_{\text{short}}/Q_{\text{long}} \approx \sqrt{L_{\text{long}}/L_{\text{short}}} = \sqrt{2}$ in this rough case. You need not compute that on exam unless asked, but the concept is that shorter = more flow.)

Exam Handbook Search Cues (Not affiliated with or endorsed by NCEES): "pipes in parallel (head loss same)", "pipes in series (flow same)", "pump head equation", "energy equation pump"

- **Variations and Additional Notes:** We have already touched on pumps in series vs parallel: If the exam asks, "How do two identical pumps in series affect the system curve?" – answer: they double the head at a given flow (so you can reach higher elevation or overcome more loss, but at the same flow rate the system would produce if one pump were running, you now have more head available so actually you can push to a new operating point with higher flow too, if curve intersects demand differently). Pumps in parallel: two pumps side by side feeding into the same header effectively can supply nearly double the flow at a given head (each shares the load). These concepts mirror electrical circuits (series pumps = add voltage, parallel pumps = add currents). Also note, sometimes a network problem might involve **an equivalent single pipe**: If you have, say, two parallel pipes between the same points, you might compute an equivalent Darcy $f(L/D)$ for the combination if needed (not common in FE, more in fluids design courses). But an awareness: the parallel pipes combined have an equivalent resistance that is lower than either alone – like parallel resistors. Another variation: **Branched networks** (like a pipe splits into two and then those go to different outlets). Continuity would apply at each split. Usually FE won't require solving a big network iteratively – that's more specialized. They stick to two-branch parallels or simple series with one pump. **Extended Bernoulli example:** If water flows from a reservoir A, through a pump, then through some pipe, and out to reservoir B at higher elevation, you'd write: $H_{\text{pump}} = h_{f,\text{pipe}} + h_{m,\text{pipe}} + (z_B - z_A) + \frac{v_B^2 - v_A^2}{2g} + \frac{p_B - p_A}{\gamma}$. Often A and B are free surfaces so $p_A = p_B = 0$ (gauge), and if B is just a reservoir outlet, $v_B \approx 0$. Then it simplifies: $H_{\text{pump}} = h_f + h_m + (z_B - z_A)$. That's the core formula to recall: **Pump head = elevation gain + losses**. If the pump can't provide that, flow won't reach B. Some problems might give you pump power instead of head – recall $W_{\text{pump}} = \rho g Q H_{\text{pump}}/\eta$ (where η is efficiency). That could tie in but belongs partly to thermo or fluids. Since we're focusing on internal flow, just remember that link if needed (the exam spec does list pumps/power in mechanical section).

- **Special calculator or solution notes:** If you need to solve for flow in parallel pipes, it might be iterative normally (since $h_f \propto Q^2$). The exam likely avoids heavy iteration. They might set up a ratio or give a hint like one pipe has twice diameter of other; then using $h_f \propto \frac{1}{D^5}$ for same length and flow, you can find how flows divide by some proportional reasoning. Or they might simply ask conceptual: "If one pipe is larger, which gets more flow?" (Answer: the larger one). If actual numbers needed, they might make it easy like "one pipe has four times the cross-sectional area of the other but same length and roughness; what fraction of total flow goes through the larger pipe?" – You could say $Q \propto D^{2.5}$ or something from Darcy–Weisbach relationships and get a ratio. But again, heavy calculations are unlikely; conceptual understanding is key.

Explanation & Analysis: Think of a pipe network as a highway system for fluids. At splits (junctions), fluid has to **decide** where to go – more will go down the easier (less resistive) route, but the key is that by the time the fluids reunite, they must have expended the same energy (head) regardless of route. That's why head loss

equalizes in parallel: if one path had even a slightly lower head loss at a given split of flows, more flow would go that way until the increased flow raised its losses to match the other path (nature finds an equilibrium). This is very much like electrical current dividing between parallel resistors: the drop (head loss ~ pressure drop) is same across each resistor.

In series, the fluid has no choice – it must go through every segment, so the resistances just add. If you have a very restrictive segment (say a small pipe section) in series with a big pipe section, the small one will dominate the head loss (like a bottleneck). Engineers often try to avoid having one tiny choke in series because it wastes a lot of pump head.

For pumps, consider them as energy sources. If one pump gives you 20 m of head at 100 L/s, two identical in series can give ~40 m at 100 L/s (neglect slight differences). If they're in parallel, two pumps can give 200 L/s at ~20 m (if the system allows that flow) – each pump pushing half the flow at the same head. So series = add head, parallel = add flow capacity for pumps. Conversely for **turbines** (not typically in FE Mechanical, but just logically), turbines in series would add drops, etc.

A simple network problem might be: two tanks connected by two parallel pipes of different diameters. We know the elevation difference (which gives a certain available head). We might be asked the flow in each pipe. We'd use that the head loss in each pipe = elevation difference (since tanks open to atmosphere, that's the driving head). Then set up Darcy–Weisbach for each: $h = f\frac{L}{D_1}\frac{v_1^2}{2g} = f\frac{L}{D_2}\frac{v_2^2}{2g}$ (assuming same lengths and friction factors for simplicity, otherwise each pipe's own f). Solve for ratio v_1/v_2 or Q_1/Q_2. And $Q_1 + Q_2 = Q_{\text{total}}$ which from h and head formula you could find actual number. That's a bit of calculation but manageable if numbers are friendly or f cancels if pipes are same roughness.

One more concept: **Network equivalence to circuits** – if it helps, you can recall: flow ~ current, pressure difference (or head) ~ voltage, resistance (head loss per flow) ~ ohmic resistance. Pipes in series: resistances add. Pipes in parallel: resistances add reciprocally (like $\frac{1}{R_{\text{eq}}} = \frac{1}{R_1} + \frac{1}{R_2}$). But be cautious applying directly because the "resistance" in pipes is flow-dependent (nonlinear, since $h_f \sim Q^2$). Still, qualitatively it's useful. And indeed, the analogy is how we solve linear approximations of networks (Hardy Cross method etc. in advanced, which FE won't dive into). For FE, just know the basic rules as outlined.

In summary, to handle any FE question on pipe networks: break it down by nodes (continuity) and loops (energy). Write a continuity equation for any junction if needed, and a Bernoulli (with losses) between relevant points. Often one equation will suffice because either flow splits evenly or one unknown to find. If multiple unknowns, you'll have as many equations as unknowns typically. And conceptually, remember – fluid doesn't mysteriously pile up or vanish at nodes, and it can't create energy out of nothing (pump excluded, which is our energy source). If you apply those truths systematically, you'll navigate these problems confidently.

Topic 05 - External Flow

Topic Introduction: External flow deals with fluid motion around solid bodies exposed to the fluid, as opposed to flow inside pipes or ducts. On the FE Mechanical Exam, external flow questions typically involve **drag forces** on objects (like the wind force on a sign or the drag on a moving vehicle) and sometimes the **lift** on aerodynamic surfaces. Mastering this topic means you can compute forces due to flowing fluids and understand how flow regime (laminar vs. turbulent) affects these forces. A common exam scenario is using the drag equation to find the force on a body at a given speed, or reasoning about how changes in flow (speed, viscosity, surface roughness) influence drag. You might also encounter conceptual questions on **drag coefficient** trends with Reynolds number or why design features (like streamlined shapes or surface dimples) reduce drag. In short, external flow matters because it determines whether an object cuts smoothly through a fluid or fights against it – a critical consideration in mechanical design and a favorite subject for exam questions.

K10.T05.S01 – Drag Force

Principle Introduction: *Drag force* is the resistive force a fluid exerts on a body moving relative to the fluid. It acts opposite to the direction of motion (or fluid flow) and increases dramatically with speed. Key intuition points include:

- **Dependence on Velocity:** Drag grows roughly with the square of relative speed – doubling speed can *quadruple* the drag force. This strong dependence means high-speed flows produce very large drag forces.
- **Role of Shape and Area:** The amount of drag depends on the object's shape and frontal area. A larger projected area facing the flow or a blunter shape will catch more fluid, generating more drag. Streamlined shapes produce much less drag than blunt ones of the same frontal area.
- **Drag Coefficient (C_D):** The drag coefficient encapsulates the effects of shape and flow regime on drag. It's an empirical, dimensionless number – higher for bluff bodies (e.g. ~1.0 for a flat plate head-on) and much lower for sleek shapes (e.g. <0.1 for an airfoil at small angle). The drag coefficient often remains roughly constant in certain flow regimes, but can change with Reynolds number (flow regime changes).
- **Fluid Properties:** Drag increases with fluid density. For example, moving through water (denser) produces much more drag than moving through air at the same speed. Viscosity also matters indirectly through Reynolds number (affecting flow regime), but the primary density dependence is straightforward: a heavier fluid imposes more force.

Equation Passport – Drag Force
Name & Purpose: **Drag Force Formula** – computes the fluid resistance (force) on an object in an external flow. Use this to find the drag on cars, balls, flat plates in wind, etc., given flow conditions and object characteristics.

Equation (SI units):

$$F_D = 1/2\ C_D\ \rho\ A\ v^2$$

Variables:

- F_D – drag force (Newtons, N) acting opposite to the flow direction.
- C_D – drag coefficient (dimensionless). A shape-dependent factor (experimentally determined) that accounts for pressure and viscous effects.
- ρ – fluid density (kg/m³). Higher ρ means more mass of fluid imparting momentum change, thus more force.
- A – **projected area** (m²) of the object *perpendicular* to flow. This is the frontal area that "catches" the fluid. *(For a sphere, $A = \pi D^2/4$; for a flat plate facing the flow, it's the plate's face area. If a plate is aligned with flow, use its surface area for friction drag calculations instead.)*
- v – relative velocity between fluid and object (m/s). If the object moves through still fluid or if fluid flows past a stationary object, use that speed of the fluid relative to the object.

Assumptions & Scope:

- Formula assumes **incompressible, steady flow** (valid for liquids and for gases at subsonic speeds where density change is negligible). For the FE exam, air and water at ordinary speeds fit this assumption.

- The flow must be a **continuous fluid medium** (no rarefied gas effects) and the object is sufficiently large compared to molecular scales (Reynolds number is the guiding parameter for drag regime).

- A must be chosen appropriately: use frontal area for form drag (bluff bodies). For purely frictional drag on thin plates aligned with flow, a different reference area (wetted area) and coefficient C_f (skin-friction coefficient) are used – see subtopic on drag coefficients for flat plates.

- C_D is presumed known (from a chart or given in the problem) for the object's shape and flow regime. **This equation by itself doesn't predict C_D; it uses C_D** from empirical data.

Limit Tests (Sanity Checks):

- **Zero velocity:** If $v \to 0$, then $F_D \to 0$. No relative motion means no drag – which matches reality.

- **No fluid (vacuum):** If $\rho = 0$, then $F_D = 0$. In space or a vacuum chamber, an object feels no drag.

- **Streamlined shape:** If C_D is extremely small (approaching 0, like an ideal streamlined body), then $F_D \approx 0$. In contrast, if C_D is large (like a parachute, $C_D \sim 1.2$ or more), drag force is significant.

- **Velocity effect:** Because of the v^2 term, a modest increase in speed greatly increases F_D. For example, going from 10 m/s to 20 m/s (doubling v) will quadruple the drag force. Always expect big drag growth with higher speeds – a common sense-check on answers.

Use vs. Sibling Equations: Use this drag force equation for **external flow problems** involving objects in a fluid stream. It is essentially a form of the dynamic pressure times area ($\frac{1}{2}\rho v^2 A$) scaled by C_D. Do **not** confuse it with frictional pressure drop formulas in internal flow (e.g. Darcy–Weisbach for pipe flow) – those deal with losses inside conduits rather than an open flow

around a body. If a problem gives you a shape and asks for force due to fluid motion, the drag equation is your go-to tool.

Common Exam Traps:

- **Wrong Area:** Make sure to use the correct reference area. For a sphere, cylinder, or any bluff body, use the projected frontal area. A frequent mistake is to accidentally use total surface area or diameter in place of area – avoid that by carefully identifying what area the fluid "sees."

- **Units Mix-up:** Keep units consistent. If v is given in km/h or miles per hour, convert to m/s (or ft/s in US customary) before plugging in. Density must be in matching units (kg/m³ for m/s, or slugs/ft³ for ft/s). Many drag calculations go wrong due to a unit mismatch on ρ or v.

- **Using C_D incorrectly:** Remember that C_D is dimensionless and typically given for a specific shape and orientation. Don't plug in a C_D for the wrong shape or assume a value without basis. The FE Exam may provide C_D in the problem statement or expect you to find it via keywords in the reference handbook. Ensure the Reynolds number range for that C_D applies to your problem's conditions (e.g. don't use a low-Re formula if the flow is clearly turbulent).

- **Neglecting Drag Direction:** Drag acts opposite to the motion. In force balance problems, be sure to assign the drag force in the correct direction (usually opposite the velocity vector or direction of motion). Sign errors can be avoided by clearly indicating drag as a resisting force in free-body diagrams.

Exam Handbook Search Cues (Not affiliated with or endorsed by NCEES): *drag force, drag coefficient, dynamic pressure, projected area* (Using these terms in the exam handbook's search can quickly bring up the drag force formula and definitions of each variable.)

Footnotes: *On the FE exam, the drag force formula is essentially an application of dynamic pressure $\frac{1}{2}\rho v^2$ multiplied by area and a coefficient. Many students remember it by recalling that $\frac{1}{2}\rho v^2$ has units of pressure, so multiplying by area gives force. Also note that in USCS units, $\frac{1}{2}\rho v^2$ will yield force per area in lbf/ft² when ρ is in slug/ft³ and v in ft/s.*

Variations and Related Forms: You might see the drag equation rearranged to solve for C_D if force is known: $C_D = \frac{2F_D}{\rho A v^2}$. This is useful if an exam question tells you the measured drag force and asks for the drag coefficient. Another variation: if asked for **dynamic pressure**, that is simply $q = \frac{1}{2}\rho v^2$; sometimes drag force is given as $F_D = C_D\, q\, A$ to emphasize dynamic pressure q. There is no fundamental difference – just algebraic rephrasing. In all cases, C_D must come from experimental data or a given figure/table. Keep in mind that C_D itself can depend on Re (next subtopic).

Special Notes (Calculator Tips): This formula is straightforward to compute on any FE-approved calculator. Just be careful to input v^2 (many errors come from forgetting to square the velocity). If you need to solve for v given F_D, remember to take a square root at the end. Also, if you're working in US Customary units, include the factor $g_c = 32.174$ lbm·ft/(lbf·s^2) where appropriate to get consistent units (though often it's easier to convert everything to SI, compute, then convert the final answer if needed).

Explanation & Analysis: The drag force equation is essentially a *force balance on a moving fluid* – it tells us how momentum transfer from a fluid to an object translates into a resistive force. Each term has a clear physical meaning: ρ indicates there's more drag in denser media because there's more mass hitting the object per time. v^2 shows the kinetic energy (or momentum) in the flow grows with the square of speed – hence faster flows hit harder. A signifies that a bigger target intercepts more fluid streamlines, so it gathers more drag. And C_D wraps up all the complicated fluid dynamics (viscous friction, pressure distribution, flow separation) into one convenient factor. A streamlined body (like a teardrop or airfoil) has a low C_D because it lets the fluid slip by with little disturbance, whereas a bluff body (like a flat plate facing the flow) has a high C_D because it creates a large wake and lots of flow disturbance. On exam day, expect that if you're computing drag, you will be given or told the appropriate C_D (or how to find it in the handbook). The main task is to plug in values correctly and watch the units. Always double-check: does the resulting force seem reasonable? For instance, if asked about wind drag on a road sign in a 30 mph wind, you should get a force on the order of tens of newtons, not thousands. Use the proportionalities as a guide: if one answer choice is off by an order of magnitude, recall that drag's v^2 dependence makes it sensitive, but not *that* crazy unless speeds or areas are huge. By understanding this equation and practicing with it, you'll develop an intuition for what a "right" answer should roughly look like, which is invaluable under exam pressure. And remember, drag is basically nature's way of saying "slow down!" – the faster you go, the louder that message (force) gets.

K10.T05.S02 – Drag Coefficient & Reynolds Number (Common Shapes)

Principle Introduction: The *drag coefficient* C_D is a key parameter characterizing how draggy or streamlined an object is, and it often **changes with the flow's Reynolds number (Re)**. Different shapes have different baseline C_D values, and within each shape, C_D can vary depending on whether the flow around it is laminar or turbulent. Understanding these trends helps you pick the right C_D and anticipate how drag will change if conditions (like speed, and thus Re) change. Core ideas include:

Reynolds Number Dependence: $Re = \frac{\rho v L}{\mu}$ (or $\frac{vL}{\nu}$) is the ratio of inertial to viscous forces in the flow, where L is a characteristic length (like diameter for a sphere or cylinder, length for a plate, chord for an airfoil). At **low Re** (very viscous-dominated, slow or small-scale flow), flows tend to be laminar and attached; at **high Re** (inertial-dominated, fast or large-scale flow), flows tend to be turbulent or have separation. The drag coefficient is usually high at extremely low Re (because viscous effects hold the flow attached like a creeping motion that "grabs" the object) and often decreases as Re increases into moderate range. However, beyond a certain point, turbulent effects can *increase* skin friction – so the trend of C_D can get complicated, sometimes with a dip then rise. The key takeaway: **you cannot assume C_D is constant for all Re; you must consider the flow regime.**

Flat Plate (Parallel to Flow): For a flat plate aligned with the flow (imagine water flowing smoothly over a flat board held flat), drag comes purely from skin friction. In laminar flow, the friction drag coefficient is relatively higher and decays with Re (as Re increases, boundary layer growth is slower relative to flow, so friction per area drops). In turbulent flow, friction drag coefficient is lower per unit Re power, but due to vigorous mixing it doesn't decay as fast with Re. Empirically: **Laminar plate:** $C_{D,\text{plate}} \approx 1.33\, Re_L^{-0.5}$ (for $10^4 < Re_L < 5 \times 10^5$), and **Turbulent plate:** $C_{D,\text{plate}} \approx$

$0.031\, Re_L^{-1/7}$ (for $Re_L > 10^6$). Here $Re_L = \frac{\rho v L}{\mu}$ with L the length of plate along flow. The sharp change in formula around 5×10^5 to 10^6 marks the transition from laminar to turbulent boundary layer on the plate. **Implication:** A longer or faster plate (higher Re) will have a lower drag coefficient per area in turbulent regime than it would if it stayed laminar, but the turbulent case will have more total drag than a laminar case would at the same high speed because the boundary layer sticks longer (we'll revisit this nuance in the Boundary Layer subtopic).

Sphere & Cylinder (Bluff Bodies): For bluff, rounded shapes like spheres and cylinders, C_D is **high at low Re**, then decreases and levels out, and can even drop suddenly in a certain Re range due to boundary layer transition. At **very low Re** (creeping flow, $Re < 1$), a sphere's drag coefficient $C_D \approx 24/Re$ – which is huge because if $Re = 0.1$, $C_D = 240$ (the fluid effectively "sticks" to the sphere and drags heavily). As Re increases into the **intermediate range** (~10^2 to 10^4), inertia starts to dominate and flow begins separating; for a sphere, C_D settles to around 0.4–0.5 in the thousands Re range. A cylinder (with flow across it) behaves similarly but typically has a higher C_D of about 1.0–1.2 in that intermediate range (a cylinder's long span makes for a wider wake). When Re becomes **very high** (~10^5 to 10^6), something interesting happens: the boundary layer on the sphere or cylinder transitions to turbulent *before* separation, which actually reduces the wake size dramatically – this is the famous *drag crisis*. For a smooth sphere around $Re \sim 3 \times 10^5$, C_D can drop from ~0.5 to ~0.1–0.2. For a cylinder, a drop also occurs but not as low, maybe from ~1.2 down to ~0.3–0.6 depending on roughness. After this drop, as Re goes even higher, C_D may rise slightly again but generally stays lower than in the pre-critical regime. **Implication:** in many mechanical engineering situations (air flow around vehicles, balls, etc.), flows are in the turbulent or transitional range where C_D is moderate (~0.1–1.2). But if dealing with tiny particles or very slow flows (like a small particle settling in oil), you must use the high $C_D = 24/Re$ type relation.

Airfoil (Streamlined Shapes): A well-designed airfoil or streamlined body has a **very low C_D at typical operating Re** (usually in the millions). For instance, an aircraft wing at small angle of attack might have $C_D \sim 0.01$–0.05, incredibly small compared to a bluff body. And importantly, C_D for an airfoil *increases* when it's tilted more or if it stalls (flow separation). Unlike bluff bodies, a streamlined shape is intended to keep flow attached as long as possible, so there isn't a wide wake causing pressure drag – most of its drag is skin friction. The drag coefficient of an airfoil rises gradually with Re in laminar flow and often drops if the boundary layer transitions to turbulent (because turbulent BL postpones separation, delaying stall). For exam purposes, you should recognize that an airfoil's drag coefficient is an order of magnitude (or more) smaller than that of a blunt object. Also, the airfoil introduces *lift*, which we'll cover next, but in terms of C_D vs Re: just know it's small and you'll typically be given a value or asked conceptually which shape has lowest C_D.

Diagram/Equation Passport – Drag Coefficient vs. Reynolds Number

Role: Drag Coefficient as a Function of Re – This encapsulates how C_D changes across flow regimes for a typical blunt object (e.g. a sphere or similarly shaped particle). It guides you in choosing the correct C_D formula or value based on the Reynolds number of the flow.

Behavior by Regime: We can summarize the drag coefficient for a sphere (and similarly-shaped objects) in piecewise form tied to Reynolds number:

- **Creeping (viscous laminar flow, $Re \ll 1$):** Flow completely laminar and attached around the sphere. The drag coefficient is **inversely proportional to** Re (very high drag for very low Re).

  $$C_D = \frac{24}{Re}, \qquad Re \lesssim 1.0.$$

  This is known as Stokes' law for small spheres – e.g. at $Re = 0.5$, $C_D = 48$.
- **Transitional Regime ($1 \lesssim Re \lesssim 10^4$):** Flow starts to separate; C_D gradually decreases and approaches a roughly constant level. An empirical fit often cited (for sphere) in this range is:

  $$C_D \approx \frac{24}{Re} + \frac{3}{\sqrt{Re}} + 0.34, \qquad (1 < Re < 10^4).$$

  This complicated expression blends the falling $24/Re$ term with other adjustments. Practically, by $Re \sim 10^3$ to 10^4, the $24/Re$ term is very small, and C_D tends toward about 0.4.
- **Turbulent Regime ($Re \gtrsim 10^4$):** The flow around the sphere is largely turbulent. Here C_D is more or less **constant or slowly varying**. For a smooth sphere in fully turbulent flow (but before drag crisis),

  $$C_D \approx 0.4 \text{ (rough order, high Re).}$$

  In reality, as Re reaches ~3×10^5 a sudden drop (the drag crisis) can bring C_D down to ~0.1–0.2. But unless the exam question specifically hints at a drag crisis scenario (e.g. mentioning a golf ball's dimples or a critical speed where drag suddenly drops), you can assume C_D stays in the same ballpark for high Re. If needed, the exam will provide a specific value or chart for C_D at very high Re.

Variables and Units:
- Re – Reynolds number = $\frac{\rho v L}{\mu} = \frac{vL}{\nu}$ (dimensionless). For a sphere or cylinder, L is typically the diameter. For a flat plate, L could be the length along flow. It's crucial to use the correct L for the geometry.
- C_D – drag coefficient (dimensionless). No units; it's a ratio of forces.
- (The piecewise formulas above implicitly include constants like 24 or 0.34 which are dimensionless and derived empirically. They apply to smooth spheres in a steady flow of a Newtonian fluid.)

How to Use (Exam-style): Determine the Reynolds number of your flow first if it's not already clear. For example, if you have a sphere of diameter 5 cm in water moving at 0.01 m/s, calculate Re (using water's ν). If Re comes out very low (≪1), use the $24/Re$ relation to get C_D. If Re is moderate (hundreds or thousands), you know C_D will be around 0.4–0.5 (maybe use a chart or given data). If Re is extremely high (10^5 or more), check if the problem hints at a reduced C_D (e.g. a rough sphere or a "critical" behavior). Generally, the exam might give a direct value or state "assume turbulent flow $C_D = 0.5$" for simplicity. Always match the regime: don't apply Stokes' law if Re is 1000, and vice versa.

Typical Values to Remember:

- **Flat plate (frontal, i.e. a thin plate perpendicular to flow):** $C_D \approx 1.1 - 1.3$ (similar to a disk). If you see a flat surface head-on, expect C_D a bit above 1.0 (lots of pressure drag).

- **Sphere (smooth, high Re ~ $10^4 - 10^5$):** $C_D \approx 0.4$. (A rough sphere like a golf ball at its optimal speed can get C_D ~0.2 due to drag crisis, but only mention if context given.)

- **Long Cylinder (across flow, high Re):** $C_D \approx 1.0$. (Think of a telephone pole in wind – quite a lot of drag.)

- **Airfoil (small angle, high Re):** $C_D \approx 0.01$–0.05. Very low – an order of magnitude smaller because it's streamlined.

- **Car (sedan shape, high Re):** $C_D \approx 0.3$ (just as a relatable example – streamlined compared to a cube, but not as good as a true airfoil).

Common Pitfalls:

- **Mixing up Shapes:** Don't apply a sphere's C_D to a cylinder or vice versa without thought. They're in the same family (bluff bodies) but have distinct values. The exam would likely specify the object or provide the coefficient.

- **Ignoring Re Range:** The formula $C_D = 24/Re$ is only valid in the creeping flow regime. Many times students try to use it at moderate Re and get nonsense results (like a C_D way too low or high). Always consider if Re is within the stated range for any empirical formula you use.

- **Forgetting Characteristic Length:** When computing Re, use the correct length. If you have a cylinder of diameter D, use $L = D$ for Re. If it's a flat plate of length L along flow, use that L. If it's an airfoil, L might be the chord length. Using the wrong L can put you in the wrong Re regime or yield the wrong C_D.

- **Interpreting Charts:** If given a drag coefficient *chart*, carefully read axes (log-log scales are common for C_D vs Re). Intermediate divisions on log axes are tricky – remember each decade typically has tick marks at 2, 4, 6, 8 (log scale). Students sometimes misread a value by a factor of 10 due to log scale unfamiliarity. Take a moment to orient yourself if using a provided graph.

Exam Handbook Search Cues (Not affiliated with or endorsed by NCEES): *drag coefficient, Reynolds number, sphere drag, flat plate friction* (These terms will help locate tables or figures of C_D vs. Re in the exam reference. For instance, searching "drag coefficient spheres" would likely show the piecewise formulas or a chart for common shapes.)

Footnotes: *The flat plate formulas given are for a very large aspect ratio plate (effectively infinite width) with one side exposed to flow (one could interpret C_D as based on one face's area). They come from boundary layer theory (Blasius solution for laminar, 1/7th power law for turbulent). If both sides of a plate were exposed, total drag would double (since both faces have a boundary layer). The FE exam usually clarifies if it's one side or both – typical convention is one side for a flat plate in a flow.* Also, note that for the turbulent plate formula $Re^{-1/7}$ – if you need to compute this on a calculator, remember that $Re^{-1/7} = Re^{-(0.142857)}$. Use the ^ or y^x key and enter 0.1429 (approx) as the exponent. Small details like this can save time and avoid confusion during the exam.

Variations and Related Concepts: Drag coefficient is closely related to the concept of **terminal velocity** for falling objects. For example, a skydiver or a particle settling in fluid will reach a speed where weight = drag force. At terminal velocity, you might use the drag equation to solve for v given balance with weight (mg). In such cases, knowing how C_D behaves is crucial: a small particle (low Re, using $24/Re$ regime) will have a very different terminal velocity formula than a large object (constant C_D regime). Also, sometimes you'll hear of **friction factor** vs. **drag coefficient** – in pipes we use friction factor f, whereas for external flows we use C_D. They're analogous in that both are dimensionless measures of drag (one per unit length vs. one per object). Just keep context straight: C_D is for a free body in fluid, friction factor is for walls in internal flow.

Explanation & Analysis: To apply this knowledge on the exam, follow a strategy: **(1)** Determine what shape and orientation you're dealing with. **(2)** Estimate or calculate the Reynolds number to identify the flow regime (laminar, transitional, or turbulent). **(3)** Select the appropriate C_D value or formula. For instance, if the problem states "a small particle (diameter 0.1 mm) falls slowly in oil," you'd suspect a low Re and lean on $C_D = 24/Re$. Conversely, "a baseball flying at 40 m/s in air" is high Re (on the order of 10^5); you'd use a C_D around 0.3–0.5 (and indeed a smooth baseball has $C_D \approx 0.3$ at that speed). **Why does C_D vary?** – at low Re, the fluid's viscosity keeps the flow attached all around the object, creating a large pressure difference and lots of drag (imagine the fluid almost moving with the object like a big syrupy blob – hard to push through). As Re increases, inertia lets the fluid streamlines break away (separate) and form a wake behind the object. In laminar separation, the wake can be wide and unstable, but once turbulence kicks in, it actually energizes the boundary layer to stick a bit longer, narrowing the wake. Narrower wake = less pressure drag. That's why a roughening (like dimples on a golf ball or trips on an airfoil) can **reduce** drag by inducing early turbulence. But there's a trade-off: turbulence in the boundary layer means higher skin friction. For bluff bodies, pressure drag dominates, so reducing it via a turbulent boundary layer yields a net drag reduction. For streamlined bodies, pressure drag is already small, so turbulence would just add unnecessary skin friction – better to stay laminar if possible. This interplay is exactly what $C_D(Re)$ captures. On exam day, you won't need to derive any of this, but you should recall the *typical C_D values and trends*: know that 0.5-ish is a common number for spheres, that very low Re means C_D skyrockets (24/Re), and that ultra-streamlined things have tiny C_D. With that in mind, you can eliminate unreasonable answer choices (e.g. if a question asks for drag on a small sphere in air and one choice implicitly uses $C_D = 24/Re$ when Re ~10000, that choice is wrong because at Re 10000, C_D should be ~0.5, not 0.0024). Use qualitative reasoning about Re to check your quantitative work.

K10.T05.S03 – Lift vs. Drag (Force Orientation and Applications)

Principle Introduction: Lift and drag are the two components of the aerodynamic force acting on a body in a flow. **Drag** acts parallel to the flow (opposing motion), while **lift** acts perpendicular to the flow. In mechanical engineering contexts, we usually care more about drag (which opposes vehicles moving through air or objects moving in fluids). Lift is crucial in aerospace (wings generating upward force) but can also appear in mechanical scenarios like turbine blades, spoilers on cars (which produce downward "negative lift" for stability), or even chimney airflow (lift on a vane). Key points to distinguish and understand:

Direction Matters: Drag always acts to slow the object relative to the fluid – it's aligned with the flow direction (opposite to the

motion). Lift acts at a right angle to the flow. For an airplane wing, lift acts upward (counteracting weight) while drag acts backward. For a car's spoiler, lift might actually push the car downward onto the road (downforce) while drag still pulls backward.

Origin of Lift vs Drag: Drag comes from **viscous friction** and **pressure differences** that act opposite the flow. Lift, on the other hand, arises when a body **redirects flow** and creates a pressure imbalance between its surfaces. For example, an airfoil with a cambered shape and angle of attack accelerates flow over the top, lowering pressure there (by Bernoulli's principle) – the higher pressure on the bottom and lower on top result in an upward lift force. Both lift and drag ultimately come from pressure and shear stress distributions on the body, but we decompose the resultant force into these two orthogonal directions for convenience.

Coefficients C_L and C_D: Just as we define a drag coefficient C_D, we define a **lift coefficient** $C_L = \frac{2F_L}{\rho A v^2}$. The form is analogous: $F_L = \frac{1}{2} C_L \rho A v^2$. Here A is usually a reference area (for wings, the planform area – wing area as seen from above). A well-designed wing might have $C_L \approx 0.5$ to 1.5 in its operating range (meaning lift force can be quite large), whereas its C_D might be only ~0.02–0.05. The ratio C_L/C_D (lift-to-drag ratio) is a measure of aerodynamic efficiency – higher means you get a lot of lift for little drag. On the exam, you likely won't need to calculate C_L for a wing (that's more advanced), but you should grasp that high lift with low drag is desirable for aircraft and that shapes optimized for lift look very different from those just minimizing drag.

Mechanical vs. Aerodynamic Context: In mechanical engineering exam problems, lift might appear conceptually. For instance, you could be asked about the **lift and drag on a spinning ball** (Magnus effect: a spinning ball generates a lateral "lift" force causing it to curve). Or maybe identify that a certain device (like a centrifugal fan blade) experiences lift-type forces as it slices through air. But mostly, the FE exam will keep it simple: recognize that drag is not the only force – there can be a perpendicular component. One classic question archetype: "An airfoil experiences 500 N of lift and 50 N of drag at a certain speed. What is the resultant force and its direction?" (You'd combine the vectors). Or a conceptual: "Compared to a flat plate at 5° angle, an airfoil at 5° generates much more lift and less drag – why?" (Answer: airfoil's shape delays stall and minimizes drag). So know that lift requires flow deflection/asymmetry and usually an angle of attack or cambered shape, whereas drag happens to everything moving in fluid, even with zero angle (symmetric).

Definition Passport – Lift vs. Drag

- **Plain-language Definition: Drag** is the fluid force *along* the direction of flow that tries to slow an object down. **Lift** is the fluid force *perpendicular* to the flow direction that can push an object sidewise or upward. For example, as air flows around a wing, drag resists the plane's forward motion while lift pushes the wing upward. Both are caused by pressure and shear forces from the fluid acting on the object.

- **Where it Matters (Exam Impact):** Drag shows up in problems about objects in wind or moving in water (boats, cars, falling objects). Lift shows up in problems about wings, propeller blades, or any surface at an angle to the flow. A common exam question might give a lift and drag scenario to test vector addition or understanding of force directions, or ask why a certain design increases lift or reduces drag. In the FE Mechanical exam, you won't design an airfoil, but you *may* need to know that, say, adding a flap increases lift (and drag), or that a spoiler on a car produces downward lift (increasing traction but also increasing drag).

- **Pitfall or Confusion Point:** It's easy to assume "lift" always means upward. In reality, lift is defined perpendicular to flow – if the flow is horizontal, lift is vertical (up or down); if flow is vertical (like air up a chimney), lift would be horizontal. Another point of confusion: an object can have *zero lift* but still plenty of drag (e.g. a flat plate head-on to flow produces drag but no lift if perfectly aligned). And lift doesn't necessarily mean the object goes up – it could be held in place (like a helicopter's rotor producing lift equal to weight). Students sometimes also confuse lift with buoyancy – buoyancy is due to static pressure in a fluid at rest (Archimedes' principle), whereas lift is a dynamic effect requiring motion and flow circulation. Keep those separate.

- **Micro-check:** *True or False:* If a wing's angle of attack increases too much, its drag will increase and its lift may suddenly drop. **(True)**. This is the stall phenomenon: beyond a critical angle, lift falls off (stall) and drag spikes due to flow separation. While this detail is more aerospace, it's a good conceptual check that lift is not unlimited and drag-lift interplay can change with flow conditions.

Exam Handbook Search Cues (Not affiliated with or endorsed by NCEES): *lift coefficient, angle of attack, airfoil, drag* (These keywords help find any reference to lift formulas or definitions in the handbook. For instance, searching "lift coefficient" would show the equation $F_L = ½C_L\rho v^2 A$ and related info on airfoils.)

Explanation & Analysis: In practical terms, **lift vs. drag** is about vector components of the aerodynamic force. On an exam problem, once you identify which way the flow is going, you can draw two perpendicular arrows on the object: one pointing against the flow (drag) and one pointing perpendicular (lift). If the object is symmetric and aligned with flow (like a flat plate head-on or a sphere), you expect no net lift (the forces are symmetric) – only drag. If the object is asymmetric or angled (like a wing or a tilted flat plate), you expect lift. The **lift equation** $F_L = ½C_L\rho A v^2$ looks just like the drag equation but with C_L. Typically C_L is strongly dependent on angle of attack: for small angles, C_L increases approximately linearly with angle (in radians) – a classic result is $C_L \approx 2\pi\alpha$ (in radians) for thin airfoils at small α. The exam might not require that formula, but it's in the handbook. Meanwhile, C_D usually has a minimum at some small angle and then increases (due to both pressure and friction drag rising). If asked, "Does a flat plate at 5° have more lift or drag?", think: At 5°, a flat plate is a terrible airfoil (flow likely separates on the back); it will actually have more drag than lift (not efficient). An airfoil at 5° would have substantial lift with low drag. The point is, shape optimizes the distribution of pressure to maximize lift. **For mechanical exam purposes**, remember: *Lift requires an angle or camber to generate an asymmetric flow.* Drag is always there as long as there's relative motion. In some cases (like spinning objects or inclined plates), the "lift" force can be lateral (like a baseball breaking sideways – technically lift in the horizontal plane). In fluid machinery, blades are essentially airfoils – a turbine blade "lifts" in the tangential direction as fluid flows over it, extracting energy; a fan blade "lifts" air, pushing it. Recognizing this helps you connect concepts: high lift blades are good for efficiency but might have to contend with drag too. Finally, be aware that increasing lift often comes at the cost of increasing drag (for example, deploying flaps on a plane increases C_L but also C_D). In exam questions, if something increases lift (like a bigger angle of attack), expect drag to go up as well – there's no free lunch. So if you ever need to qualitatively choose an effect, choose the one that pairs increased lift with increased drag, or reduced drag with possibly reduced lift if streamlining. By

understanding lift vs drag, you'll not only solve direct questions but also avoid being tricked by questions that hide a lift concept in a mechanical situation. It's one more tool in your engineering toolkit – even if you're not designing airplanes, the principles of lift can sneak into surprising corners of mechanical design problems.

K10.T05.S04 – Boundary Layer Concepts (Laminar vs. Turbulent Flow over Surfaces)

Principle Introduction: The *boundary layer* is a thin region of fluid next to a solid surface where the fluid's velocity changes from zero (at the wall, due to the no-slip condition) to the free-stream value. In external flows, the state of the boundary layer – laminar or turbulent – has a profound impact on drag. Qualitatively:

- **Laminar Boundary Layer:** Flow in the boundary layer is smooth and orderly (fluid moves in layers). Laminar BLs have **lower skin friction** (they "slide" more easily over the surface) but are **less resistant to separation**. If the object's shape causes the pressure to increase along the surface (an adverse pressure gradient, typical on the back half of a bluff body), a laminar BL tends to separate earlier, creating a larger wake (and thus higher pressure drag).
- **Turbulent Boundary Layer:** Flow in the BL is chaotic and mixed. Turbulence brings high-momentum fluid from outside closer to the wall. A turbulent BL has **higher skin friction** (it "grips" the surface more due to eddies rubbing along the wall), but it is **more resistant to flow separation** because the mixing energizes the slower fluid near the wall. This means a turbulent boundary layer can remain attached longer over a surface, resulting in a smaller wake behind a body and therefore **lower pressure drag**. In many external flows, the total drag is the sum of friction drag (due to shear in the BL) and pressure drag (due to separation and wake). Turbulence increases the former but can drastically cut down the latter.
- **Transition and Critical Reynolds Number:** As flow moves along a surface (like from the leading edge of a flat plate or the nose of a sphere), it may start laminar and then transition to turbulent at some point. The Reynolds number at which this happens (critical Re) depends on factors like surface roughness and free-stream turbulence. For a flat plate in air with a smooth surface, a common critical Re_L (based on length from leading edge) is around 5×10^5 (this corresponds to the earlier mention in subtopic 2). Beyond that, flow typically becomes turbulent. For a sphere, critical $Re \approx 3 \times 10^5$ as noted, which can be lowered by roughness (rough surface triggers earlier turbulence). The exam might ask conceptually about these transitions (e.g., why a golf ball has dimples – answer: to trip the boundary layer to turbulent at lower Re, reducing drag by delaying separation).
- **Thickness and Growth:** A boundary layer starts thin at the leading edge and grows thicker downstream. Laminar BL grows gradually, turbulent BL grows faster in thickness (more mixing). This matters in designs: for example, a thin BL might not consume much of a flow passage, whereas a thick one reduces effective flow area. In external flow, thick BL on a wing means less effective wing area and can alter lift distribution. However, the FE exam is unlikely to dive into BL thickness formulas – just know qualitatively that turbulent BL is thicker and more energy-filled.
- **Heat and Mass Transfer Note:** Though our focus is drag, note that a turbulent BL also enhances heat transfer (more mixing). So if you see a combined concept question (like heat transfer on a flat plate), recall that turbulent flow increases both friction and heat transfer coefficients.

Definition/Note Passport – Boundary Layer (BL)

- **Plain-language Definition:** The **boundary layer** is the thin "coat" of slow-moving fluid that clings to the surface of an object as fluid flows past. Right at the surface, the fluid velocity is zero (relative to the surface) due to viscosity (no-slip condition). Moving outward from the surface, the flow speed ramps up until it matches the main flow. This layered region – from 0 at the wall to ~99% of free-stream velocity at the outer edge – is the boundary layer.

- **Laminar vs. Turbulent:** In a **laminar BL**, fluid particles slide in smooth paths; the layer is orderly. In a **turbulent BL**, eddies and swirls mix the fluid; the layer is full of fluctuations. Laminar BLs produce less friction drag but can separate easily if pressured; turbulent BLs produce more friction drag but hang on longer, reducing separation. For example, on the front of a sphere the BL might be laminar, but if it turns turbulent halfway around, it stays attached longer and the sphere's wake (behind it) shrinks, cutting drag.

- **Exam Perspective (Why it Matters):** Many FE exam questions boil down to *"which is better, laminar or turbulent, for drag?"* and the answer is *"it depends on the situation."* If we want to minimize drag on a **flat plate** (where all drag is friction), we prefer laminar flow (lower friction). If we want to minimize drag on a **bluff body** (where most drag is pressure from separation), we might prefer the boundary layer to be turbulent to avoid a big wake (hence the golf ball example: laminar flow around a smooth ball separates early, huge wake, high drag; a dimpled ball triggers turbulence, smaller wake, lower drag). So, the exam may ask conceptually about this trade-off. They might also test recognition that **critical $\boldsymbol{Re \sim 5 \times 10^5}$** for transition on a flat plate (a number hinted by the handbook correlations) or that roughness can induce turbulence.

- **Pitfall or Common Misunderstanding:** Don't assume "turbulent = always more drag" or "laminar = always good." It's context-dependent. Laminar flow is indeed "smoother" so it has less friction drag, but in separated flows it can be bad news because it doesn't resist separation. Turbulent flow is "messy" so it has more friction drag on a surface, but it can dramatically cut pressure drag by controlling separation. Students often memorize one of these facts and then apply it blindly; the exam might exploit that. Instead, think: *For streamlined surfaces, keep flow laminar; for bluff bodies, a bit of turbulence can help.* Another nuance: sometimes people mix up the term "boundary layer" with the wake or entire flow. Remember, the boundary layer is just the region near the surface; once the flow separates, the region behind is called a **wake**, not a boundary layer (the BL ends at the separation point).

Exam Handbook Search Cues (Not affiliated with or endorsed by NCEES): *boundary layer, laminar flow, turbulent flow, separation, Reynolds critical* (While the handbook might not explicitly define "boundary layer" in prose, searching these terms can bring up the equations or criteria related to laminar/turbulent flow and perhaps the flat plate drag correlations which implicitly involve BL concepts.)

Explanation & Analysis: Let's pull this together with a practical mindset for the exam. When you face a question about drag or external flow, mentally visualize the flow: **Is there a boundary**

layer developing? Will it stay attached or separate? For instance, say the question involves a long flat plate in air flow – you imagine a boundary layer growing along it. Likely they want you to compute drag assuming either laminar or turbulent correlation (or maybe both, piecewise). If they mention the plate is "smooth and 2 m long" and give you a flow speed, you might check Re to see if 2 m at that speed exceeds 5×10^5. If yes, you know flow will transition, so maybe you need to apply the turbulent formula or split the plate into laminar/turbulent sections (though the FE usually keeps it simpler). Another scenario: a question asks, "Why do dimpled golf balls travel farther than smooth ones?" The answer in terms of BL: dimples trip the BL to turbulent, delaying separation, reducing pressure drag, hence less total drag and longer flight. Or, "A designer wants to reduce drag on a flat airplane wing – should the surface be polished smooth or made rough?" For a wing (streamlined, mostly laminar flow desirable), the answer: polished smooth (to keep flow laminar as long as possible, minimizing friction drag). These conceptual applications of BL theory are classic exam fodder.

We don't usually calculate boundary layer thickness or do differential equations on the FE – it's all about understanding effects. One formula occasionally referenced is the laminar BL thickness $\delta \approx 5.0 \frac{x}{\sqrt{Re_x}}$ (for flow over a flat plate, where x is distance from leading edge). This tells you BL grows with sqrt of x. But unless a question specifically gives that, you likely won't need it. Instead, focus on recognizing *when* a flow will likely be laminar or turbulent. **Rules of thumb:** internal flow: laminar if Re < 2300, external flow on a flat plate: laminar up to $Re \sim 10^5 or\ 10^6$. Also, roughness: a rough surface triggers turbulence sooner (lowers critical Re). So if a problem says "a sphere has a rough surface," you infer that the drag crisis (turbulent BL) will happen at a lower Re than for a smooth sphere. This might be given to justify using a lower C_D.

Finally, consider the combined drag: $D_{\text{total}} = D_{\text{friction}} + D_{\text{pressure}}$. A laminar BL minimizes D_{friction}, a turbulent BL can minimize D_{pressure}. In an extreme case like a very streamlined car, friction might be a big part of drag, so laminar flow is helpful. In a blunt object like a parachute, pressure drag dominates, so the flow is massively separated (turbulence in BL or not, it's going to separate anyway!). Yet, even parachutes sometimes have vents to control separation. The big picture is: boundary layer state control is a tool to manage drag. For the exam, keep a clear head about cause and effect: laminar vs turbulent is not inherently "good" or "bad" – it's about what it does to separation and friction. If you keep that straight, you'll answer those conceptual questions correctly. And if nothing else, remember the punchline: **Golf balls have dimples not for style, but for science!** By roughening the surface, they ensure a turbulent boundary layer which dramatically reduces drag, allowing your swing to send the ball farther. That real-world example encapsulates this subtopic's essence – exactly the kind of understanding the FE exam loves to test.

Topic 06 - Compressible Flow

Topic Introduction: Compressible flow deals with gas motion at speeds where density changes become significant. In these high-speed flows, pressure and temperature can change sharply, and familiar formulas from incompressible flow no longer apply directly. For the **FE Mechanical Exam**, compressible flow concepts typically appear in questions about **nozzles, shock waves, and Mach number calculations**. You might be asked to determine if a flow is subsonic or supersonic, find stagnation (total) pressure given a Mach number, apply a normal shock relation to find pressure after a shock, or identify if a nozzle flow is **choked** (at its max flow limit). This chapter covers the essential principles, equations, and **exam tactics** for Mach number regimes, isentropic flow relations, normal shock waves, and choked flow conditions.

K10.T06.S01 – Mach Number and Flow Regimes

Principle Introduction:

- **Mach number (M)** is the ratio of a flow's speed to the local speed of sound in that fluid. It indicates how compressible the flow is.

- **Flow regimes** are defined by M: **subsonic** (M < 1), **sonic** (M = 1), and **supersonic** (M > 1). In subsonic flow, disturbances (sound waves) can move upstream, but in supersonic flow, the flow outruns its pressure waves, often leading to shock waves.

- Flows with **M < 0.3** are typically treated as *incompressible* (negligible density change) – this is a common threshold where compressibility effects are minor. As M increases beyond ~0.3, changes in density, pressure, and temperature become increasingly important.

- Mach number is **dimensionless** and appears in many formulas for high-speed aerodynamics and gas dynamics. It's a key parameter for deciding whether to use compressible flow equations or simpler incompressible approximations.

Exam Handbook Search Cues (Not affiliated with or endorsed by NCEES): Mach number; speed of sound; subsonic; supersonic; compressible vs incompressible

Footnotes:

- Mach number uses consistent units for speed: make sure the fluid velocity and sound speed are in the **same units** (e.g. both in m/s or ft/s) when computing M.

- For an ideal gas, the acoustic wave speed depends on temperature and is computed as: $a = \sqrt{\gamma R T}$ (with T in absolute units like K or °R), where γ is the specific heat ratio and R is the specific gas constant [^1].

[^1]: The exam reference handbook denotes the ratio of specific heats as k (which is $\gamma = c_p/c_v$). Remember to use **absolute temperature** (Kelvin or Rankine) in the sound speed formula.

Variations, related forms, typical values:

- **Typical values:** At standard conditions in air, the speed of sound a is about 343 m/s (1125 ft/s). So, a flow at 100 m/s (≈328 ft/s) is roughly M ≈ 0.29 (incompressible range), while a flow at 400 m/s is M ≈ 1.17 (supersonic).

- **Transonic regime:** Around M ≈ 0.8–1.2, flows are called *transonic* (mixed subsonic and supersonic regions). This regime is complex (shocklets can form) but detailed transonic analysis is beyond the FE exam scope. Just recognize transonic is near M = 1.

- **Hypersonic:** M > 5 is *hypersonic* (extreme speeds); not directly tested on the FE, but it underscores how Mach number classifies flow severity.

- For engineering gases like air, γ is typically 1.4 (diatomic gas). If you need the speed of sound and have temperature, plug $\gamma = 1.4$ unless told otherwise.

Special notes: When calculating Mach, it's often straightforward: divide velocity by sound speed. **Be careful with units** – e.g. if velocity is given in ft/s, use sound speed in ft/s. If you need to compute sound speed, remember to convert °C to Kelvin or °F to Rankine before plugging into $a = \sqrt{\gamma R T}$.

Equation Passport: Mach Number

- **Name and purpose: Mach Number (M)** – Indicates the compressibility regime by comparing flow speed to the speed of sound.

- **Professional equation:** $M = \frac{V}{a}$

- **Variables and units:**

- M – Mach number (dimensionless)
- V – flow velocity relative to the fluid (m/s or ft/s)
- a – local speed of sound in the fluid (m/s or ft/s)

- **Assumptions and scope:**

- Applicable to any fluid flow (usually gas) where V and a are measured at the same location/state.
- a depends on fluid properties (for ideal gases $a = \sqrt{\gamma R T}$). Assumes an ideal gas if you're computing a; otherwise a can be measured or given.
- Useful for identifying compressibility: Flows with $M \ll 1$ can be treated as incompressible (constant density), whereas high-M flows require compressible flow analysis.

- **Limit tests (sanity checks):**

- If $V = 0$, then $M = 0$ (stationary fluid, as expected).
- If $M = 1$, $V = a$ – the flow is moving at the speed of sound (sonic condition).
- As $M \to 0$, compressibility effects vanish (no significant density change). As M grows large, expect strong compressibility and possibly shock waves.

- **Use vs. sibling equations:** Use the Mach number to decide between **compressible vs. incompressible** formulas. For example, use compressible flow relations (like isentropic or shock equations) instead of Bernoulli's equation when M is not negligible. If $M < 0.3$, incompressible assumptions (constant density, Bernoulli equation) are usually acceptable for exam problems.

- **Common exam traps:**

- Forgetting that Mach is dimensionless: do not report it with units.
- Mixing units for V and a (e.g. using V in m/s and a in ft/s by mistake). Always convert to a common unit system.
- Assuming a high Mach number flow can be treated with incompressible formulas – this will give wrong results. Conversely, overthinking compressibility for very low Mach flows wastes time; check M first.

Explanation & Analysis: Mach number tells you **how fast the flow is relative to the medium's ability to carry disturbances**. In practical terms, if $M < 1$ (subsonic), pressure changes can propagate upstream, and the flow smoothly adjusts around objects. If $M > 1$ (supersonic), the flow is going so fast that pressure waves can't get upstream, leading to shock waves and drastic property changes. The FE exam may simply ask you to compute M (e.g. a jet travels at 250 m/s in air, what is M?) or to identify the flow regime (subsonic, supersonic, etc.).

Term by term, the formula $M = V/a$ is straightforward: V is the fluid's speed relative to the ground or pipe (depending on context), and a is the speed of sound at the fluid's condition. **Physically**, a is higher at higher temperatures (for ideal gases) because molecules move faster, carrying sound faster. If V is much smaller than a (say a gentle breeze vs. sound speed), M is small and the air behaves nearly incompressibly. If V approaches or exceeds a, the kinetic energy is high enough to compress the gas significantly – that's when compressible formulas (like those in the next subtopics) come into play. Always double-check Mach number in problems: it guides which formulas to use and warns you of phenomena like shocks if $M > 1$. For example, a flow at $M = 2$ means the flow is supersonic and you should be thinking about potential shock waves or using compressible energy equations rather than the standard Bernoulli equation.

K10.T06.S02 – Isentropic Flow Relations (Stagnation & Area–Mach)

Principle Introduction:

- **Isentropic flow** means the process is adiabatic (no heat transfer) and reversible (no friction or shocks). In such ideal conditions, an *ideal gas* flowing in a nozzle or duct conserves its **stagnation (total) enthalpy** – which leads to constant stagnation pressure and temperature along a streamline.

- **Stagnation properties:** If you take a moving flow and slow it down *isentropically* to zero velocity, the resulting pressure P_0 and temperature T_0 are the stagnation (or total) pressure and temperature. They are higher than the static values because the flow's kinetic energy is converted into pressure and internal energy without losses. The relations between static and stagnation state are functions of Mach number (for an ideal gas).

- **Key isentropic relations:** For an ideal gas, $T_0/T = 1 + \frac{\gamma-1}{2}M^2$. Similarly, P_0/P and ρ_0/ρ have formulae involving M^2 and γ. These allow you to find how much pressure or temperature rise occurs due to compressibility at a given Mach.

- **Nozzle flow and area–Mach relation:** In a nozzle (or any varying area passage), an isentropic flow accelerates or decelerates depending on the area change and Mach. **Subsonic flow** ($M < 1$) speeds up when the area narrows (like a converging nozzle) and slows down when area widens. **Supersonic flow** ($M > 1$) does the opposite: it speeds up if area expands (diverging section) and slows if area contracts. There is a critical point at **Mach 1** (sonic) which occurs at the smallest area (the **throat**). The **area–Mach number relation** quantifies this: it gives the required area ratio A/A *to achieve a certain Mach number in isentropic flow (where* A is the area when $M = 1$ at the throat).

- The isentropic relations are used extensively for **nozzles, diffusers, and jet engine problems**. On the FE exam, you might be asked to compute a stagnation pressure or temperature given Mach and static values, or to determine the Mach at a nozzle exit given the area ratio.

Exam Handbook Search Cues (Not affiliated with or endorsed by NCEES): isentropic; stagnation pressure; stagnation temperature; total pressure; area ratio; nozzle; throat; critical flow area

Footnotes:

- Stagnation values are always taken **relative to a reference frame moving with the fluid**. For example, P_0 at a point in a flow is the pressure you'd get by isentropically bringing the fluid at that point to rest.

- Use **absolute pressure and temperature** in these formulas. P_0 and P must be in absolute terms (e.g. Pa or psi absolute), and T in Kelvin or Rankine. Avoid using gauge pressure or Celsius in isentropic relations.

- The exam reference may use k for γ (ratio of specific heats) [^2]. Remember $\gamma = 1.4$ for air unless otherwise specified.

[^2]: In some tables, γ (specific heat ratio) might appear as k. Both mean c_p/c_v. Check context to avoid confusion.

Variations, related forms, typical values:

- **Stagnation pressure and density:** In addition to temperature, the isentropic formulas include: $\frac{P_0}{P} = (1 + \frac{\gamma-1}{2}M^2)^{\frac{\gamma}{\gamma-1}}$ and $\frac{\rho_0}{\rho} = (1 + \frac{\gamma-1}{2}M^2)^{\frac{1}{\gamma-1}}$. These come from combining energy and state relationships for an ideal gas.

- **Area–Mach relation:** The nozzle area required for a given Mach number (or vice versa) is given by

$$\frac{A}{A^*} = \frac{1}{M}\left[\frac{2}{\gamma+1}\left(1+\frac{\gamma-1}{2}M^2\right)\right]^{\frac{\gamma+1}{2(\gamma-1)}}$$

Here A^* is the area when the flow is choked ($M = 1$). Notably, for any area ratio $A/A^* < 1$, there is no physical solution above Mach 1—the smallest area enforces sonic conditions. Also, for a given $A/A^* > 1$, there are two possible M solutions: one subsonic and one supersonic (the flow will pick the one consistent with upstream/downstream conditions).

- **Typical values:** Using $\gamma = 1.4$, if $M = 2$, then $T_0/T = 1 + 0.2(4) = 1 + 0.8 = 1.8$ so stagnation temperature is 1.8 times static; $P_0/P = (1 + 0.8)^{3.5} \approx 7.82$ (stagnation pressure almost 8 times static). These large ratios show how dramatically pressure increases when kinetic energy is converted to pressure at supersonic speeds.

- **Special case $M \rightarrow 0$:** All these isentropic ratios tend to 1 as $M \rightarrow 0$ (which is consistent: at zero velocity, stagnation and static states coincide).

Special notes: Calculating P_0/P or A/A^* by hand can be time-consuming. On the exam, typically you'd use the provided formulas or values. If using a calculator, compute in steps to avoid mistakes: e.g. for P_0/P, first compute $1 + \frac{\gamma-1}{2}M^2$, then raise it to $\gamma/(\gamma-1)$. Also ensure your calculator is in the correct mode for any temperature unit conversions (especially if using the gas constant R).

Equation Passport: Isentropic Stagnation Pressure

- **Name and purpose: Stagnation Pressure Ratio** – Relates static pressure to stagnation (total) pressure in an isentropic flow. It tells us how much the pressure would rise if a moving gas were slowed to rest isentropically.

- **Professional equation:** $\frac{P_0}{P} = (1 + \frac{\gamma-1}{2} M^2)^{\frac{\gamma}{\gamma-1}}$

- **Variables and units:**

- P_0 – stagnation (total) pressure (Pa, psi, or any absolute pressure unit)
- P – static pressure at the given state (same units as P_0)
- M – Mach number at the given state (dimensionless)
- γ – ratio of specific heats c_p/c_v (dimensionless, typically 1.4 for air)

- **Assumptions and scope:**

- Flow is ideal gas and **isentropic** between the state where P is measured and the stagnation state (no energy loss, no shock).

- Valid for Mach numbers from 0 up to where a normal shock or other non-isentropic effect intervenes. Do *not* apply across a shock (use shock relations instead for that jump).

- Assumes a single phase gas with constant γ (reasonable for common gases over moderate temperature ranges).

- Stagnation pressure is frame-dependent (defined relative to gas decelerated to zero speed). In a flow with no losses, P_0 stays the same along the streamline.

- **Limit tests:**

- At $M = 0$: $P_0/P = (1+0)^{\gamma/(\gamma-1)} = 1$. This makes sense: a static fluid has equal static and total pressure.

- At $M = 1$: $P_0/P = (1 + \frac{\gamma-1}{2})^{\gamma/(\gamma-1)}$. For $\gamma = 1.4$, that is $(1 + 0.2)^{3.5} \approx 1.89^{3.5} \approx 3.67$. So for sonic flow, stagnation pressure is a few times static pressure.

- As M increases, P_0/P grows rapidly (nonlinear): e.g. at $M = 3$, $P_0/P \approx 36$ (huge pressure amplification). If your calculation yields P_0/P only slightly above 1 for a high Mach, you likely mis-applied the formula (or used gauge pressure by mistake).

- **Use vs. sibling equations:** Use this compressible isentropic formula instead of the incompressible Bernoulli's equation when dealing with high-speed flow. For example, Bernoulli's equation ($P + \frac{1}{2}\rho V^2 = \text{const}$) would *underestimate* pressure rise at high Mach because it ignores compressibility. Also, use this instead of normal shock formulas if no shock is present; if a shock occurs, break the problem into isentropic parts separated by a shock calculation.

- **Common exam traps:**

- Confusing stagnation pressure P_0 with static pressure P in problem statements. Typically P_0 is higher; if the flow slows down, pressure goes to P_0. Know which one you're solving for.
- Using the wrong γ or mixing up γ and R. For instance, plugging 287 J/(kg·K) (air's gas constant) in place of γ will ruin the calculation – γ is unitless (~1.4), whereas R has units.
- Forgetting to convert temperature if you had to use the sound speed or energy equation to find Mach. If using T_0/T relation, T must be absolute. Similarly, ensure pressure is absolute.
- Applying this formula through a shock or across a frictional pipe run – if the process isn't isentropic, this relation won't hold. The FE exam may give multi-step problems where you first use a shock relation, then an isentropic relation separately.

Explanation & Analysis: These isentropic relations are basically the **compressible-flow replacement for Bernoulli's equation**. They let you relate conditions at one point in a flow to a stagnation state (or between two different points, as long as no energy is lost between them). For example, if a problem gives you a pressure and Mach number at the inlet of a nozzle, you can find the stagnation pressure P_0. That P_0 will stay the same throughout the nozzle (assuming isentropic flow), so at the exit you can then find the exit Mach or pressure by applying the formula inversely. This is a common exam strategy: use stagnation quantities as "bridges" between different locations in a flow when no losses occur.

Let's break down the stagnation pressure equation: $\frac{P_0}{P} = (1 + \frac{\gamma-1}{2} M^2)^{\frac{\gamma}{\gamma-1}}$. Inside the parentheses, $1 + \frac{\gamma-1}{2}M^2$ comes from the energy of the flow: $\frac{\gamma-1}{2}M^2$ represents the kinetic energy turned into internal energy (fractional temperature rise). Raising it to the power $\gamma/(\gamma-1)$ comes from the ideal gas isentropic relation between pressure and temperature ($P_0/P = (T_0/T)^{\gamma/(\gamma-1)}$). Each symbol: M is how fast the flow is, and we see that if $M = 0$, the term in parentheses is 1 so $P_0/P = 1$ (no pressure change). If M is large, the term inside is big and the exponent magnifies it further. The result: a high P_0/P means a huge difference between stagnation and static pressure – a hallmark of high Mach flows.

In practical terms, for the FE exam, you might get a question like: *"Air at 200 kPa and 300 K flows at Mach 2. What is the stagnation pressure?"* You'd plug into the formula (with $\gamma = 1.4$) to find $P_0 \approx 200 \times 7.82 \approx 1564$ kPa. Or conversely, you might be given a stagnation pressure and a static pressure and asked to find Mach. In that case, you'd set up P_0/P, plug numbers, and solve for M (which might require a bit of trial or recognizing a standard ratio from the handbook). The area–Mach relation is less likely to require heavy calculation on exam day; more often, you'd use it conceptually to realize, for instance, that a given nozzle must have a throat for a supersonic flow, or that if a flow is subsonic in a convergent-divergent nozzle, the larger exit area means it slowed back down (perhaps due to over-expansion causing a normal shock). If a question specifically mentions a "choked" nozzle or Mach 1 at the throat, you know to apply these isentropic formulas up to $M = 1$ at the throat (and that's the limit of mass flow, which ties into the next subtopic on choked flow). Overall, mastering the isentropic relations allows you to tackle any ideal compressible flow problem by breaking it into isentropic stretches and, if needed, shock or choke points.

K10.T06.S03 – Normal Shock Relations

Principle Introduction:

- A **normal shock wave** is a thin, sudden compression wave that occurs when a supersonic flow is decelerated to subsonic speed over a nearly discontinuous jump. "Normal" means the shock front is perpendicular to the flow direction (head-on to the flow).

- Across a normal shock, the flow's pressure and temperature rise sharply, density increases, and velocity drops. Importantly, Mach number goes from $M_1 > 1$ **before the shock** to $M_2 < 1$ **after the shock**. The shock process is highly irreversible (entropy increases), so stagnation pressure drops across a shock (some total pressure is lost as heat).

- **Key relations:** The ratios of downstream (after-shock) to upstream (before-shock) properties are determined by the conservation of mass, momentum, and energy for an adiabatic shock. For an ideal gas, these can be expressed as: $\frac{P_2}{P_1} = 1 + \frac{2\gamma}{\gamma+1}(M_1^2 - 1)$, $\frac{\rho_2}{\rho_1} = \frac{(\gamma+1)M_1^2}{(\gamma-1)M_1^2+2}$, and $\frac{T_2}{T_1} = \frac{P_2/P_1}{\rho_2/\rho_1}$ (which follows from those two using ideal gas law). These are the **normal shock relations** for static properties.
- There is also a relation for the Mach number after the shock: M_2 can be calculated as $M_2^2 = \frac{1+\frac{\gamma-1}{2}M_1^2}{\gamma M_1^2 - \frac{\gamma-1}{2}}$. This shows that M_2 is always less than 1 if $M_1 > 1$.

- On the FE exam, normal shock problems usually involve computing the pressure or temperature after a shock given the initial Mach (and perhaps initial pressure or temperature). They might also ask conceptually what happens to Mach or pressure across a shock. Remember: a normal shock greatly increases pressure and temperature, and the flow slows to subsonic.

Exam Handbook Search Cues (Not affiliated with or endorsed by NCEES): normal shock; shock wave; P_2/P_1; M_1; M_2; supersonic flow

Footnotes:

- Normal shock formulas assume a single-phase ideal gas with constant γ, and that the shock is standing perpendicular to the flow. In reality, a shock thickness is extremely small (few microns), and all the changes happen almost instantaneously as the flow crosses that thin layer.

- The stagnation pressure ratio across a normal shock (not given above) can be derived but is less commonly needed: it's always less than 1 (i.e., $P_{0,2} < P_{0,1}$). The loss is larger for stronger shocks (higher M_1).

- Don't confuse normal shocks with **oblique shocks** (which occur at an angle in supersonic flow around wedges or airfoils). The FE exam sticks to normal shocks (flow in a duct or normal to a blunt body).

- If $M_1 = 1$, there is no normal shock – it's just at the brink of forming a shock. If $M_1 < 1$, a normal shock can't form upstream (you can't decelerate subsonic to subsonic via a shock; instead, subsonic deceleration is smooth).

Variations, related forms, typical values:

- **Downstream Mach M_2:** As noted, M_2 is given by $M_2^2 = \frac{1+\frac{\gamma-1}{2}M_1^2}{\gamma M_1^2 - \frac{\gamma-1}{2}}$. For quick estimation: if M_1 is just above 1, M_2 will be just below 1. If M_1 is very large, M_2 approaches a certain minimum (for $\gamma = 1.4$, even at $M_1 \to \infty$, M_2 tends to about 0.23).

- **Example values:** For air ($\gamma = 1.4$) with an upstream Mach $M_1 = 2.0$:
- $P_2/P_1 \approx 4.5$ (pressure increases 4.5 times),
- $\rho_2/\rho_1 \approx 2.67$ (density roughly 2.7 times higher),
- $T_2/T_1 \approx 1.68$ (temperature ~68% higher).
- And $M_2 \approx 0.577$ (the flow slows to subsonic ~ Mach 0.58).
These values illustrate how a moderately strong shock boosts pressure a lot, but temperature increase is more modest (most of the kinetic energy goes into pressure rise and some into internal energy). Stronger shocks (higher M_1) magnify these jumps even more.

- **Weak vs strong shock:** As $M_1 \to 1^+$, the shock is weak (tiny pressure jump). As M_1 grows, the shock strength increases and the formulas approach their asymptotic limits. For $\gamma = 1.4$, a very strong shock (say $M_1 = 5$ or 10) yields enormous pressure ratios (as noted above, dozens to hundreds). Such extreme Mach numbers are beyond normal mechanical engineering scenarios, but the trend is clear: higher M_1 means a much stronger shock.

Special notes: If you need to use these relations on the FE exam, they're usually provided or easy to derive with the handbook's guidance. Calculate step by step: first find P_2/P_1 from M_1, then maybe use that to get T_2/T_1 etc. Keep track of which side of the shock you're on: apply the formula once per shock. And remember, a normal shock only happens if the upstream is supersonic – if a problem gives $M_1 < 1$, you might be dealing with a different scenario (like no shock, or perhaps a shock downstream in a convergent-divergent nozzle if it accelerates beyond 1 somewhere).

Equation Passport: Normal Shock (Pressure & Density Ratios)

- **Name and purpose: Normal Shock Relations** – Compute downstream pressure and density given upstream Mach (for a shock standing normal to flow). These equations let you find the sudden jumps in properties across a shock.

- **Professional equations:**

$$\frac{P_2}{P_1} = 1 + \frac{2\gamma}{\gamma+1}(M_1^2 - 1)$$

$$\frac{\rho_2}{\rho_1} = \frac{(\gamma+1)M_1^2}{(\gamma-1)M_1^2+2}$$

$$\frac{T_2}{T_1} = \frac{P_2/P_1}{\rho_2/\rho_1}$$

using the ideal gas law connection.

- **Variables and units:**

- M_1 – Mach number upstream of the shock (dimensionless, must be > 1 for a shock to exist)
- M_2 – Mach number immediately after the shock (dimensionless, will be < 1)
- P_1, P_2 – static pressure before and after shock (Pa, psi, etc., absolute)
- T_1, T_2 – static temperature before and after (K, °R)

- ρ_1, ρ_2 – density before and after (kg/m³, slug/ft³, etc.)
- γ – specific heat ratio (dimensionless, ~1.4 for air)
- *Note:* Subscript 1 = upstream (before shock), 2 = downstream (after shock).

- **Assumptions and scope:**

- Steady one-dimensional flow of an ideal gas; shock is exactly normal to the flow.
- No heat transfer or external work (adiabatic), but **not isentropic** (entropy increases across shock).
- Applies only if $M_1 > 1$. If $M_1 = 1$, the shock collapses to a infinitesimal disturbance; if $M_1 < 1$, these formulas are not applicable (no shock forms).
- These relations are for the immediate jump across the shock. If you have a complex flow with a shock and then further expansion, treat each segment separately (shock first, then isentropic flow, etc.).

- **Limit tests:**

- $M_1 \to 1^+$ (just above 1): then $P_2/P_1 \to 1$ (a very weak shock yields almost no pressure change), $\rho_2/\rho_1 \to 1$, and $M_2 \to 1^-$ (just below 1). This is consistent: a barely supersonic flow only needs a tiny shock to become subsonic.
- M_1 large: ρ_2/ρ_1 approaches $(\gamma+1)/(\gamma-1)$ (≈6 for air), while P_2/P_1 and T_2/T_1 increase without bound as M_1 grows. For instance, at $M_1 = 5$, $P_2/P_1 \approx 36$; at $M_1 = 10$, $P_2/P_1 \approx 116$. In theory $P_2/P_1 \to \infty$ as $M_1 \to \infty$ (ideal gas), though practical limits intervene.
- Check conservation: The formula for T_2/T_1 must equal $(P_2/P_1)/(\rho_2/\rho_1)$. If you compute P_2/P_1 and ρ_2/ρ_1 and their ratio doesn't match your T_2/T_1, something went wrong in calculation.

- **Use vs. sibling equations:** Use these normal shock equations to analyze a shock in a duct or nozzle instead of using isentropic assumptions. If a flow problem says "shock" or has supersonic flow decelerating abruptly, apply these relations for that jump. Do not try to apply Bernoulli's or isentropic formulas across a shock – those would ignore the entropy increase and give wrong answers. In contrast, if the flow deceleration is gradual and subsonic, no shock occurs and you'd use isentropic or Bernoulli methods instead.

- **Common exam traps:**

- Plugging in $M_1 < 1$ into shock formulas – they don't apply (and will give imaginary or nonsense results for M_2). If you see a subsonic Mach, a normal shock is not the right tool.

- Mixing up M_1 and M_2 in calculations. Always start with the known upstream M_1 to find downstream quantities. M_2 is not an input to these basic formulas, it's an output.

- Forgetting that pressure *increases* across a normal shock. A shock is a compression: P_2 must be greater than P_1. If you accidentally invert the formula or use it wrong and get $P_2 < P_1$, that's a red flag. Similarly, M_2 must come out less than 1; if you computed $M_2 > 1$, you probably applied something incorrectly.

- Not recognizing a hidden shock scenario: e.g. a converging-diverging nozzle with a back pressure high enough to force a shock in the diverging section. In such a case, you might need to apply isentropic relations up to the shock, then shock relations, then isentropic again after the shock. This is advanced, but just remember: handle the shock with these formulas separately from the smooth portions.

Explanation & Analysis: The normal shock equations are all about enforcing conservation laws across that very thin shock layer while acknowledging that entropy increases. In plain language, a normal shock is nature's way of slowing down a supersonic flow very quickly, at the cost of irreversibly converting some ordered energy into disorder (heat). The FE exam usually simplifies things: you're either directly applying one of the given shock formulas or conceptually comparing before and after states.

Looking at the pressure relation $P_2/P_1 = 1 + \frac{2\gamma}{\gamma+1}(M_1^2 - 1)$, notice how if $M_1 = 1$ this gives 1 (no jump), and as M_1 grows, the $(M_1^2 - 1)$ term drives P_2/P_1 up. For $M_1 = 2$, we plug in $\gamma = 1.4$: $P_2/P_1 = 1 + \frac{2(1.4)}{2.4}(4-1) = 1 + \frac{2.8}{2.4} \times 3 \approx 1 + 1.167 \times 3 = 1 + 3.5 = 4.5$, matching our earlier example. The density formula similarly ensures mass continuity through the shock (density has to jump since velocity drops). We often don't memorize the temperature formula because it's easiest to get T_2/T_1 by dividing P_2/P_1 by ρ_2/ρ_1 – a handy check on exam day if you have the other two.

In an exam problem, you might see something like: *"A normal shock stands in a duct. Upstream of the shock, air is Mach 3 at 50 kPa and 240 K. Find the pressure and temperature immediately after the shock."* You'd do $P_2 = P_1 \times (shockpressureratio)$ and $T_2 = T_1 \times (shocktemperatureratio)$. With $M_1 = 3$, $\gamma = 1.4$, you'd find $P_2/P_1 \approx 10.3$ (for M=3) and $\rho_2/\rho_1 \approx 5.36$, then $T_2/T_1 \approx (10.3)/(5.36) \approx 1.92$. So $P_2 \approx 515\ kPa, T_2 \approx 461\ K$. A big jump! Recognize that a shock can create such drastic changes. If the question instead asked for M_2, you could either use the M_2 formula or look it up; for $M_1 = 3$, M_2 comes out to ~0.475.

The key in analysis is to appreciate **what a shock does**: it's a one-time abrupt event that raises pressure, making the flow subsonic. After the shock, if the flow continues (say in a nozzle), you'd then treat that downstream region as subsonic flow possibly slowing further in a diverging section (or whatever the setup is). The exam will not require deriving these relations, just using them correctly. So focus on selecting the right formula for the right property and plugging in M_1. Always double-check the trend: post-shock pressure up, Mach down – that sanity check can save you from algebra mistakes under pressure.

K10.T06.S04 – Choked Flow in Nozzles

Principle Introduction:

- **Choked flow** happens in a nozzle or restriction when the velocity at the narrowest section (the throat) reaches sonic speed (Mach 1). Once this occurs, lowering the downstream pressure further does not increase the mass flow rate—the flow becomes limited to a maximum, or "choked," value.

- In a converging nozzle (or any orifice), as you gradually lower the pressure at the exit (increase the pressure difference), the flow speed in the throat increases. Up to a critical pressure ratio, the throat Mach remains below 1 and mass flow rises. But once Mach 1 is achieved at the throat, that throat becomes a **sonic barrier**: information can't travel upstream through the sonic point, so further lowering the exit pressure doesn't draw more flow through.

- For an ideal gas, the condition for choking can be described by a **critical pressure ratio**. For example, for air ($\gamma = 1.4$), the flow chokes when P_{exit}/P_0 drops to about 0.528 or lower. At that condition, Mach 1 is at the throat and the mass flow is at its maximum for the given upstream stagnation pressure P_0 and temperature T_0.

- Choked flow is important in designs of nozzles, rockets, and safety relief valves. On the FE exam, you might be asked conceptually what happens when a nozzle is choked (e.g., "will mass flow increase if I reduce downstream pressure further?") or to identify if a given flow is choked given pressure conditions. It's less common to compute the exact mass flow, but understanding the cutoff behavior is key.

Exam Handbook Search Cues (Not affiliated with or endorsed by NCEES): choked flow; critical pressure; throat; Mach 1; mass flow rate

Footnotes:

- Choking is a *compressible flow* phenomenon – liquids (which are nearly incompressible) don't "choke" the same way; instead, if pressure is too low they may cavitate (which is a different limitation).

- When a nozzle is choked, the flow downstream of the throat can be supersonic (if expanded properly in a diverging section) or it may form a normal shock within the nozzle if the pressure drop is excessive. But the mass flow at the throat stays limited by Mach 1 conditions.

- The term "choked" doesn't mean flow is stopped – it means **limited** flow. Think of it like a traffic jam at the speed of sound: no matter how much you *push*, you can't force more mass through unless conditions upstream change.

Variations, related forms, typical values:

- **Critical pressure ratio:** For a given γ, the ratio (P_{exit}/P_0)crit *at which choking occurs can be derived from isentropic relations. For air ($\gamma = 1.4$), $P/P_0 \approx 0.528$* is the threshold. That corresponds to about 52.8% of upstream stagnation pressure – any lower exit pressure (greater pressure drop) will not increase flow.

- **Mass flow formula at choke:** The maximum mass flow rate through a throat of area $A^*$is given by

$$\dot{m}_{\max} = A^* P_0 \sqrt{\frac{\gamma}{R\,T_0}} \left(\frac{2}{\gamma+1}\right)^{\frac{\gamma+1}{2(\gamma-1)}}$$

This looks complicated, but it's just the isentropic flow rate evaluated at $M = 1$in the throat. The important takeaway is that $\dot{m}_{\max}$is proportional to upstream $P_0/\sqrt{T_0}$and throat area A^*, but is independent of further decreases in downstream pressure once choked.

- Typical values: In air at standard conditions, reaching Mach 1 in a nozzle requires a substantial pressure drop. For example, flowing from a reservoir at 100 kPa, the flow will choke when exit pressure hits roughly 52.8 kPa or lower. At that point, the flow at the throat is sonic. Increasing reservoir pressure or enlarging the throat area are the only ways to get more flow beyond that point.

- After choking:* If a nozzle has a diverging section after the throat (making it a convergent-divergent nozzle), the flow can expand to supersonic speeds beyond the throat, but the mass flow rate still won't exceed the choked limit set at the throat (unless P_0 changes). Any extra expansion just affects pressure and Mach downstream, not the total throughput (unless a shock forms, which is another story).

Special notes: This concept is often tested conceptually. If you're using the FE exam's provided equations, you might look up "critical flow" or Mach 1 conditions. On allowed calculators, you won't likely need to input the full mass flow formula unless provided; more often you'd compare pressure ratios or Mach numbers. Remember: if they say the nozzle is choked, you immediately know Mach 1 at throat and that further lowering exit pressure does nothing to increase mass flow.

Definition Passport: Choked Flow

- **Plain-language definition: Choked flow** – the condition in a gas flow where increasing the pressure drop no longer increases the flow rate, because the flow speed at the narrowest point has reached the speed of sound (Mach 1). Essentially, the flow is maxed out.

- **Where it matters (exam impact):** Shows up in problems with nozzles or orifices. On the FE exam, you might be asked if a given nozzle is choked or what happens if the downstream pressure is decreased further. Recognizing choked flow tells you that the mass flow is at its maximum for the given upstream conditions.

- **Pitfall or confusion point:** Some think "choked" means no flow – in fact, it means **limited** flow. The flow still occurs, just at a fixed maximum rate. Also, students might try to use Bernoulli's equation or an incompressible assumption when a flow is actually choked – this would give wrong results, because compressibility is critical here.

- **Micro-check:** *True or False:* If a nozzle is choked, lowering the exit pressure will increase the mass flow rate. **(False.)** Once choked, mass flow can't increase without raising upstream pressure or enlarging the throat.

Explanation & Analysis: Choked flow can be understood by thinking about information propagation in a fluid. When the throat hits Mach 1, conditions at the downstream side of the nozzle can no longer send pressure signals upstream through the throat – it's like traffic piling up because cars can't go faster than the speed limit. In practical terms, if you have a pressurized tank feeding a nozzle to the atmosphere, initially as you open the nozzle wider (or reduce back-pressure), flow increases. But beyond the critical pressure ratio, the gas at the throat is going sonic; it's flowing out as fast as it can, and making the outlet vacuum-like won't suck it out any faster.

For FE exam purposes, you should quickly identify choked conditions. A typical question might give upstream pressure and temperature, a throat diameter, and a low downstream pressure, then ask for the mass flow or to compare two scenarios. If one scenario has a sufficiently low back-pressure that the flow is choked, the mass flow difference between that and an even lower back-pressure scenario would be zero (because both are choked at the same max flow). Another common analysis is to use isentropic relations up to Mach 1 to find conditions at the throat (like P, T at $M = 1$) and then compute mass flow.

Term by term, the idea is: $\dot{m} = \rho\, V\, A$. In compressible flow, ρ and V at the throat depend on how pressure drops. At choking, $V = a$ (speed of sound) and the density is fixed by the critical pressure ratio. That's why plugging $M = 1$ into the isentropic formulas gives you the combination of ρ and V that maximize $\dot{m}$. The equation provided for $\dot{m}_{\max}$ comes from that substitution. You don't need to memorize that equation; just remember the proportionalities (more P_0 or area means more flow) and the concept that beyond a point, you hit a ceiling.

In summary, choked flow is the gas dynamics equivalent of a fully saturated flow rate. Recognize it by Mach 1 at the throat or by a given critical pressure drop, and remember that it tells you “this is as much flow as you’re going to get under these conditions.” That insight can save you time by not over-complicating the analysis once you know the flow is choked.

Topic 07 - Power and Efficiency

Topic Introduction: This topic covers how to quantify the energy transfer in **fluid machinery** – devices that add energy to fluids (like pumps, fans, and compressors) or extract energy from fluids (like turbines). Understanding power and efficiency is crucial for the FE Mechanical Exam because many questions ask you to compute input or output power, or to compare ideal versus actual performance of these machines. On exam day, you might be asked to determine the **pump horsepower** required to lift water a certain height at a given flow rate, the **work needed to compress** a gas between two pressures, or the **power output of a turbine** given steam inlet/outlet conditions and an efficiency. The problems often boil down to applying energy equations with the right efficiency factor, so mastering these formulas and concepts will let you tackle a common archetype of FE questions with confidence.

K10.T07.S01 – Pump Power and Efficiency

Principle Introduction: Pumps are devices that **add energy to a fluid**, typically to increase its pressure or elevation (height). The key idea is that the fluid gains **hydraulic power** (also called water power) equal to the weight flow rate times the head increase. However, pumps are not 100% efficient – you must supply more **shaft power** to account for losses (friction, turbulence, motor heat, etc.). The ratio of useful fluid power output to the shaft power input is the **pump efficiency**. In exam problems, you'll often compute how much motor power (in kW or hp) is required for a pump to deliver a certain flow Q against a head H, given the pump's efficiency. Keep in mind: a pump's job is like lifting the fluid to a higher potential (or pressure) – and you pay an energy cost to do that, with some extra to cover inefficiencies.

- A pump converts mechanical energy (shaft work) into fluid energy (pressure head).
- **Hydraulic power** delivered to the fluid = $\rho g Q H$ (think of $\rho g H$ as weight per volume × height = energy per volume, times flow volume per time).
- **Brake (shaft) power** input is higher than hydraulic power if efficiency $< 100\%$. Pump efficiency η_p ties them as: $\eta_p = \frac{\text{Fluid power out}}{\text{Shaft power in}}$.
- Typical pump efficiencies range from 60% to 90% (larger well-designed pumps are usually more efficient than small or off-design ones).
- Exam problems may give flow, head, and efficiency to find power (or vice versa), or ask conceptual questions about what affects pump power (e.g. increasing flow or head increases required power linearly).

Exam Handbook Search Cues (Not affiliated with or endorsed by NCEES): "pump power equation", "pump efficiency", "brake horsepower", "head increase"

Equation Passport – Pump Power Equation – calculates the **shaft power** needed to move a fluid at a given flow rate and head:

Name and purpose: Pump Power Equation – computes the required input power to a pump's shaft given the fluid flow, head gain, and pump efficiency.

Equation:

$$P_{\text{shaft}} = \frac{\rho\, g\, Q\, H}{\eta_p}$$

This formula relates the fluid's weight flow rate $\rho g Q$ and head H to the shaft power. If the pump were ideal ($\eta_p = 1$), the shaft power would equal $\rho g Q H$ – the minimum power to raise the fluid. With efficiency less than 1, more power must be supplied.

Variables and Units:

P_{shaft} – pump shaft power input (SI: watts (W); US customary often given in horsepower (hp))

- ρ – fluid density (SI: kg/m^3; US: slug/ft^3)
- g – acceleration of gravity (SI: $9.81\ \text{m/s}^2$; US: $32.17\ \text{ft/s}^2$)
- Q – volumetric flow rate of fluid (SI: m^3/s; US: ft^3/s)
- H – head added to the fluid (energy per unit weight, in meters or feet of fluid)
- η_p – pump efficiency (decimal fraction, e.g. 0.75 for 75% efficiency)

Assumptions and Scope:

Incompressible flow: Valid for liquids (e.g. water, oil) where density is constant. For gases, pumping results in negligible density change (if used, treat H as equivalent pressure head).

- **Steady-state:** Flow rate Q and head H are assumed steady (no transient fluctuations).
- **Head definition:** H represents the total head increase the pump provides to the fluid (includes elevation gain and/or pressure increase, often measured in length units). It assumes minimal change in kinetic energy between pump inlet and outlet (often the case if pipe diameters are similar).
- **Single-phase fluid:** No phase change (e.g. no cavitation causing vapor bubbles); the formula addresses only liquid water-like behavior.

Limit Tests (sanity checks):

If efficiency $\eta_p \to 1.0$ (100%), then $P_{\text{shaft}} \to \rho g Q H$. This is the **ideal** case: all shaft work goes into increasing fluid energy, with no losses.

- If $Q \to 0$ (no flow), then $P_{\text{shaft}} \to 0$. Indeed, if a pump is "dead-headed" (pumping against a closed valve so flow is zero), theoretically no power is delivered to the fluid. In practice, the motor would still draw some power to overcome internal losses, but our ideal formula indicates zero fluid power.
- If $H \to 0$ (pump isn't raising pressure or elevation), $P_{\text{shaft}} \to 0$ as well – no energy needed to move a fluid through a flat, frictionless path at constant pressure (again, real pumps would have internal losses, but no useful work).

Use vs. Sibling Equations: Use this pump power equation for liquid-moving pumps where density stays constant. It's essentially an energy balance: converting electrical or mechanical energy into fluid potential energy. **Do not use this for gas compressors**, where

density changes significantly – for those, use the gas compression work formulas (adiabatic/isothermal processes) instead. Also, note the similarity to fan/blower power (which uses $Q\Delta P$ for gases at low pressure rise) – but for pumps, we use $Q\rho gH$ since head H is more convenient for liquids.

Common Exam Traps:

- **Efficiency in the right place:** A very common mistake is to *multiply* by efficiency when you should divide. Remember $\eta = \frac{\text{output}}{\text{input}}$. Here, output (to fluid) is ρgQH. If η_p is 80%, that means only 80% of the input shows up as fluid energy – so the input must be larger: divide by 0.8, not multiply.
- **Unit consistency:** Ensure units are consistent when plugging numbers. In US units, ρgHQ gives power in ft·lb/s. To convert to horsepower, you'd divide by $550\ \text{ft}\cdot\text{lb/s}$ per hp (or use $g = 32.17\ \text{ft/s}^2$ and ρ in slug/ft^3 directly). In SI, the formula yields watts directly if you use SI units throughout. A classic pitfall is using ρ of water = 1000 kg/m³, $g = 9.81$, H in *meters*, Q in *L/s* or *m³/hr* by accident. Always convert flow to m³/s (or ft³/s) for the formula.
- **Using head vs. pressure:** Don't confuse head H (in length units) with pressure difference ΔP. They relate by $\Delta P = \rho gH$ for a liquid. If a problem gives a required pressure increase (e.g. 300 kPa), convert it to head: $H = \Delta P/(\rho g)$, then plug in. Conversely, if given head in feet and asking for pressure, multiply by ρg.
- **Neglecting motor efficiency:** Often the pump itself has efficiency η_p, and the motor driving it has efficiency η_m. The *total* efficiency $\eta_{\text{total}} = \eta_p \times \eta_m$. If a problem provides a motor efficiency or asks for "electrical power draw", make sure to include that. For example, if the fluid power is 5 kW and pump is 70% efficient, shaft power = ~7.14 kW; if the motor is 90% efficient, the **electric power from the wall** = 7.14/0.90 ≈ 7.93 kW. Don't stop at pump shaft power if the question implicitly needs the power source input.

Explanation & Analysis: The pump power equation essentially states that the **power input required** is the fluid's weight flow rate (ρgQ = weight per second) times the height (or head) you're lifting the fluid, adjusted for efficiency. Think of ρgQH as the *ideal* power to raise a fluid at flow rate Q up by height H. For example, if you pump water (density ~1000 kg/m³) at 0.05 m³/s up a 10 m rise, ρgQH = 1000×9.81×0.05×10 ≈ 4,905 J/s = 4.905 kW of hydraulic power. If the pump is 70% efficient, you'd actually need about $4.905/0.7 \approx 7.0$ kW at the shaft to accomplish this. Each symbol in the equation has a clear physical meaning: Q is how much volume per second you're moving – push more flow, you need more power. H is how much energy per unit weight each bit of fluid needs – bigger height or pressure rise, more energy required per unit of fluid. ρ and g ensure we're converting that head into energy per volume and ultimately into power.

When using this equation, **double-check units** at the outset. A common strategy: convert everything to SI units, compute power in watts, then convert to horsepower if needed (1 hp = 746 W). Alternatively, in USCS units, you might use a formula variation: $P_{\text{hp}} = \frac{\gamma QH}{550\times\eta_p}$, where $\gamma = \rho g$ is the specific weight (lb/ft³) of the fluid. For water, $\gamma \approx 62.4\ \text{lb/ft}^3$ at room temp. Plug Q in ft³/s, H in ft, and divide by 550 (ft·lb/s per hp) and by efficiency, to get horsepower. It's essentially the same formula packaged for US units.

On the FE Exam, pump problems are usually straightforward plug-and-chug if you identify the right numbers: look for keywords like "flow rate", "head" or "pressure rise equivalent to X ft of water", and efficiency. Be mindful of whether they ask for **output power (water power)** or **input power (brake power)**. If a question asks "how much power is the pump delivering to the fluid?", it implies ρgQH (with no efficiency factor, that *is* the delivered power). If it asks "how much power must the motor supply?", that implies you need the higher value after dividing by efficiency. The term **"brake horsepower (BHP)"** typically refers to the shaft power delivered to the pump (i.e. what you measure on the output shaft of the motor), whereas **"water horsepower"** refers to the hydraulic power ρgQH. Efficiency ties them: water hp = BHP × η_p. Remembering these distinctions will help you avoid one of the most common exam day errors in fluid mechanics calculations.

K10.T07.S02 – Gas Compressor Work (Adiabatic vs. Isothermal)

Principle Introduction: Compressors are machines that **do work on gases** to raise their pressure (and typically temperature). Unlike liquids in a pump, gases are **compressible** – meaning the process path (how you compress it) affects how much work is required. Two extreme cases bound the work input: - **Isothermal compression:** The gas is compressed very slowly or cooled during compression, so it stays at nearly constant temperature. This path requires the **least work** input because the gas gives off heat as it's compressed, reducing the effort needed. - **Adiabatic compression:** The gas is compressed quickly with no heat escape (ideal insulated process). This is essentially an **isentropic** compression (if assumed reversible) and requires **more work** than isothermal because all the energy goes into raising the internal energy (temperature) of the gas as well as pressure. Most real compressors operate somewhere between these extremes, following a **polytropic process** $PV^n =$ constant, where n (the polytropic exponent) is between 1 (isothermal) and k (adiabatic exponent = specific heat ratio c_p/c_v). For air, $k \approx 1.4$, so a typical moderate compressor with some cooling might have n around 1.2–1.3.

On the FE exam, you may encounter: calculating the **work required per unit mass** or the power for a given flow through a compressor, given initial and final pressures and either assuming adiabatic (use k) or isothermal, or a given efficiency. You might also need to use the concept of **isentropic efficiency** for compressors, which compares the ideal isentropic (adiabatic reversible) work to the actual work input. Key point: compressing a gas always takes work, but **the process matters** – so identify if the problem hints at "slow cooling" (isothermal) or "well-insulated" (adiabatic), etc., and use the appropriate formula.

- **Work input increases gas enthalpy:** A compressor's work essentially goes into raising the **enthalpy** of the gas (plus maybe some kinetic energy if high velocity, but usually negligible). In an ideal adiabatic compressor, $W_{\text{in}} = \Delta h$ per unit mass.
- **Isentropic (adiabatic reversible) vs actual:** If no heat is lost, the temperature rises significantly; isentropic efficiency η_c is defined to gauge how much extra work is required in reality compared to the ideal. For compressors, $\eta_c = \frac{\text{ideal isentropic work}}{\text{actual work}}$. This is less than 1 since actual machines are not reversible and often have additional losses.

- **Process exponent n:** You might see the polytropic formula with an exponent n. If $n = k$ (ratio of specific heats), that's the adiabatic reversible case. If $n = 1$, that's isothermal. Many exam problems assume either the adiabatic case (if it says "compressor is adiabatic" or doesn't mention cooling) or the isothermal case (occasionally, especially for an air pump scenario).
- **Units alert:** Work per unit mass might be given in kJ/kg (in SI) or in BTU/lbm (in US units). Make sure to use absolute pressures (Pa or psi absolute) in gas compression formulas – compressing from 1 atm to 5 atm means P1=101 kPa, P2=505 kPa absolute, for instance.

Exam Handbook Search Cues (Not affiliated with or endorsed by NCEES): "adiabatic compression", "isothermal compression work", "compressor efficiency", "polytropic process"

Equation Passport – Gas Compression Work (Polytropic Process) – computes the **work input per unit mass** required to compress a gas from an initial pressure P_1 to a higher pressure P_2 following a polytropic path $PV^n =$ const:

Name and Purpose: *Polytropic Compression Work Equation* – gives the formula for the work (energy) needed to compress each kilogram of an ideal gas when the pressure is raised from P_1 to P_2 under a process with exponent n. It helps you determine how much work a compressor requires under various conditions (with isothermal and adiabatic as special cases).

Equation (per unit mass):

$$w_{\text{comp}} = \frac{n}{n-1} R\, T_1 [(\frac{P_2}{P_1})^{\frac{n-1}{n}} - 1]$$

This formula assumes an ideal gas and a reversible process. R here is the specific gas constant for the gas (e.g. for air, $R \approx 287$ J/(kg · K)). The expression in brackets accounts for the change in pressure; the prefactor $\frac{n}{n-1} RT_1$ ties in the initial state properties and process index. For $n = 1$ (isothermal), this formula approaches $w = RT_1 \ln(P_2/P_1)$, and for $n = k$ (adiabatic), it becomes $w = \frac{k}{k-1} RT_1 \left[(P_2/P_1)^{(k-1)/k} - 1\right]$.

Variables and Units:

- w_{comp} – work input **per unit mass** of gas (SI units: J/kg or kJ/kg; US customary: ft·lb_f/lbm or BTU/lbm)
- P_1 – initial (suction) pressure of the gas (Pa or psi, absolute)
- P_2 – final (discharge) pressure (Pa or psi, absolute)
- T_1 – initial absolute temperature of the gas (K in SI; °R in US units)
- n – polytropic exponent (dimensionless). $n = 1$ for isothermal, $n = k$ (ratio of specific heats c_p/c_v) for adiabatic; n is typically between 1 and k for real processes with heat transfer.
- R – specific gas constant (J/(kg·K) in SI; in US, you might use R in units like ft·lb/(lbm·°R)). Note: $R = R_{\text{universal}}/M$, where M is the molar mass. For example, for air $M \approx 28.97$ kg/kmol, so $R \approx 287$ J/(kg · K).
- (Alternatively, sometimes the formula is written using specific volume v_1 at state 1: $w = \frac{n}{n-1} P_1 v_1 \left[(P_2/P_1)^{(n-1)/n} - 1\right]$. This is equivalent, since $P_1 v_1 = RT_1$ for an ideal gas.)

Assumptions and Scope:

- **Ideal gas behavior:** The gas follows $PV = RT$ at all times. Real gases at moderate pressures (a few atm) typically satisfy this well enough for exam purposes.
- **Polytropic, quasi-static process:** The compression follows a well-defined PV^n path (meaning the process is internally reversible enough to use the formula). Rapid, irreversible compression would require more complicated analysis, but FE problems usually assume an idealized process or give an efficiency to correct for deviations.
- **No phase change:** The gas remains a single phase. (For example, compressing air well above its dew point so no condensation occurs.)
- **Single-stage compression:** The formula is for one stage from P_1 to P_2. If the problem involves multi-stage compressors with intercooling, you would apply the formula in steps or use a different strategy (usually not needed unless explicitly described).
- **Negligible kinetic and potential energy change:** We assume the compressor's work mostly goes into P and T. Any velocity or elevation changes of the flow are ignored unless stated (standard practice in thermodynamic analysis of compressors).

Limit Tests:

- **Isothermal limit ($n \to 1$):** As n approaches 1, the formula should reduce to $w = RT_1 \ln(P_2/P_1)$. Indeed, taking the limit $n \to 1$ of the given expression yields that result. This is a good check: if a problem says the compression is isothermal, you can confidently use $w = RT_1 \ln(P_2/P_1)$ (which gives a smaller value than any $n > 1$ case for the same pressure ratio).
- **Adiabatic limit ($n \to k$):** Plugging $n = k$ gives $w = \frac{k}{k-1} RT_1 \left[(P_2/P_1)^{(k-1)/k} - 1\right]$. This matches the standard isentropic compression work formula (essentially $c_p(T_2 - T_1)$ since $T_2/T_1 = (P_2/P_1)^{(k-1)/k}$ for isentropic). This will be the maximum work required for a given P_2/P_1 because no cooling reduces the effort.
- **Small pressure difference:** If $P_2 \approx P_1$ (pressure ratio → 1), then $(P_2/P_1)^{(n-1)/n} - 1 \approx$ a small number. The work w will approach 0 as expected (compressing from, say, 1.0 bar to 1.1 bar requires relatively little energy, especially if done isothermally).
- **Use vs. Sibling Equations:** Use this polytropic compression equation when dealing with **compressors (gas)** and the process path is specified or implied. If the process is explicitly **isothermal**, you can simplify to the $RT\ln(P_2/P_1)$ form (which is easier to compute). If the process is **adiabatic** and you have k, you might use the k-form directly or recall that $w = c_p(T_2 - T_1)$. Keep in mind that for quick estimates, $c_p \Delta T$ is often used if you know or can find the temperatures. **Do not use liquid pumping formulas** ($\rho g H$) for gases – they will severely

underestimate the work because gases compress and temperature changes matter. Also, **don't confuse this with turbine work** (which would have opposite sign and uses $h_{in} - h_{out}$ instead).

Common Exam Traps:

- **Using the wrong formula for the process:** If a problem states or implies isothermal compression (for example, "the cylinder is cooled during compression" or "find minimum work"), do **not** use the adiabatic formula – use the $\ln(P_2/P_1)$ version. Conversely, if it's clearly adiabatic (or no mention of cooling), do not assume you can use the isothermal shortcut. Choosing the wrong process equation can give an answer off by a noticeable factor (often isothermal work is significantly less than adiabatic for big pressure changes).
- **Forgetting to use absolute pressure:** This is a big one. Always convert pressures to absolute before taking ratios or differences in thermodynamics formulas. If $P_1 = 0$ gauge (atmospheric) and $P_2 = 50$ psi gauge, the ratio (P_2/P_1) is NOT $50/0$ (which is nonsense). Convert: $P_1 \approx 14.7$ psi abs, $P_2 = 64.7$ psi abs. Then $P_2/P_1 \approx 4.4$. Likewise in SI, use Pa (or bar absolute). Gauge values must be adjusted.
- **Mixing up R and k or using R incorrectly:** Remember R is *not* 8.314 unless you divided by molar mass already. Many students confuse R (specific gas constant per kg) with the universal gas constant. For example, for air: $R_{\text{air}} = 287\ \text{J/(kg} \cdot \text{K)}$, not 8.314. If you prefer to use the universal gas constant $R_u = 8.314\ \text{J/(mol} \cdot \text{K)}$, you must incorporate the molar mass M in kg/mol and use $R_u T_1/M$ in the formula. It's often simpler to stick with the per-mass R.
- **Not accounting for efficiency when asked for actual work:** The formula given is for an ideal process (minimum work). Real compressors require more work. If a compressor's **isentropic efficiency** η_c is provided (often 0.7–0.9 range), remember that $\eta_c = \frac{\text{ideal (isentropic) work}}{\text{actual work}}$. This means actual work $w_{\text{actual}} = \frac{w_{\text{ideal}}}{\eta_c}$. Students sometimes mistakenly multiply by efficiency (resulting in a smaller number, which would actually be less work than ideal – not possible). The correct approach: ideal work is the *fraction* of actual work that accomplishes the compression; if efficiency is 80%, you need 1/0.8 = 1.25 times the ideal work input to get the job done.
- **Temperature units and values:** Ensure T_1 is in absolute temperature (Kelvin or Rankine). For instance, compressing air starting at 25°C (298 K) vs at 25 K are very different scenarios. Also, if you compute T_2 for an adiabatic process (using $T_2 = T_1(P_2/P_1)^{(k-1)/k}$), keep it in Kelvin. A mistake like using °C in the formula will throw off the calculation.
- **Rounding and interpolation:** If property tables or c_p values are involved (less likely on FE, since they often give constants), use the given values. If no c_p is given and it's air at moderate temperature, assume $c_p \approx 1.005\ \text{kJ/(kg} \cdot \text{K)}$ if needed for a quick calculation.

Explanation & Analysis: The compression work equation encapsulates how **difficult it is to squeeze a gas**. Let's break it down qualitatively: the term $\frac{n}{n-1}$ is greater than 1 and is a factor that comes from integrating $P\,dv$ for the process. If $n = 1$ (isothermal), this factor formally becomes infinite, but the $(P_2/P_1)^{(n-1)/n} - 1$ goes to a logarithm, resulting in a finite $RT_1 \ln$ form. For n close to 1, compression is easier (lots of heat removal), so the work is smaller. For larger n, especially $n = k$ for adiabatic, the factor $\frac{k}{k-1}$ is significant (for air, $k/(k-1) = 1.4/0.4 = 3.5$), and the exponential term also contributes – making work much larger.

Consider compressing air from 1 atm to 4 atm, starting at 300 K. If done isothermally at 300 K: $w = 287 \cdot 300 \ln(4) \approx 287 \cdot 300 \cdot 1.386 = 119{,}360$ J/kg ≈ 119 kJ/kg. If done adiabatically ($k = 1.4$): $w = \frac{1.4}{0.4}\, 287 \cdot 300\left[4^{(0.4/1.4)} - 1\right] = 3.5 \cdot 287 \cdot 300(4^{0.2857} - 1)$. Now $4^{0.2857} = e^{0.2857 \ln 4} = e^{(0.2857 \cdot 1.386)} = e^{0.396} \approx 1.486$, so $(4^{0.2857} - 1) \approx 0.486$. Then $w \approx 3.5 \cdot 287 \cdot 300 \cdot 0.486 \approx 146{,}454$ J/kg ≈ 146 kJ/kg.

That's about 23% higher than the isothermal work. If the compressor isn't perfectly adiabatic and rejects some heat (polytropic $n$maybe 1.2–1.3), the required work would be in between these values. This example illustrates: removing heat (isothermal) significantly reduces the energy required to reach the same pressure.

For FE exam problems, you often won't need to derive anything – just recall or find the formula and plug in values. A strategy: check if the problem implies an isentropic process – if yes, you might also use energy conservation in the form $W_{\text{in}} = \dot{m}(h_2 - h_1)$ for an ideal gas, where $h_2 - h_1 = c_p(T_2 - T_1)$. If they give you temperatures directly, that's even easier. If they give pressures and say "reversible adiabatic", you might find T_2 via $T_2 = T_1(P_2/P_1)^{(k-1)/k}$, then use $c_p(T_2 - T_1)$. All roads lead to the same answer.

Also, be aware of how **compressor efficiency** might come into play: suppose the ideal isentropic work per mass is 120 kJ/kg, but the compressor's $\eta_c = 0.80$. The actual work per mass will then be $120/0.8 = 150$ kJ/kg. If the mass flow is, say, 2 kg/s, the shaft power needed is $2 * 150 = 300$ kJ/s $= 300$ kW. Keep track of whether the question asks for work per unit mass (in which case answer in kJ/kg or similar) or total power for a given flow (kW or hp).

A final note: compressors often have interstage cooling (like multi-stage compressors with intercoolers) to approach an isothermal efficiency without each stage doing too much work. On the FE exam, a common conceptual question is "Which process requires the least work input for gas compression between two pressures?" – the answer is **isothermal** (because heat removal helps). And "Which requires the most?" – **adiabatic (isentropic)**, since all the work stays as internal energy. Remembering these concepts can earn easy points on conceptual questions when you don't even need to calculate anything.

K10.T07.S03 – Turbine Power and Isentropic Efficiency

Principle Introduction: Turbines are the opposite of compressors: they **extract work** from a flowing fluid by expanding it to a lower pressure. Common examples are steam turbines in power plants, gas turbines in jet engines, or even hydraulic turbines in dams. In a turbine, the fluid's enthalpy (or pressure-energy) drops, and that drop is converted to shaft work output. An ideal turbine (adiabatic

and reversible) would maximize this work output, producing power equal to the fluid's enthalpy drop. Real turbines have losses (friction, turbulence, heat loss), so the actual work output is less – characterized by an **isentropic turbine efficiency** η_T. For turbines, efficiency is defined as $\eta_T = \frac{\text{Actual work output}}{\text{Isentropic (max possible) work output}}$. This is logically flipped from compressor efficiency, since for a turbine you *want* as much work out as possible (actual is smaller than ideal), whereas for a compressor you want to minimize work in (actual is larger than ideal).

In the FE exam context, you might be asked to calculate the **power output** of a turbine given inlet and outlet conditions (using the steady-flow energy equation, essentially $W_{\text{out}} = \dot{m}(h_{\text{in}} - h_{\text{out}})$ for an adiabatic turbine). Or you may need to apply the efficiency: e.g., given inlet conditions and outlet pressure, find the actual outlet enthalpy if the turbine efficiency is X%. Another potential question type is conceptual: identifying that increasing turbine efficiency means the actual exit enthalpy will be closer to the ideal (lower) value, hence more work extracted.

- **Energy extraction:** In a turbine, high-pressure fluid expands to lower pressure, **doing work** on the turbine blades. The **decrease in enthalpy** (or pressure head) of the fluid is what gets converted to work.
- **Steady flow energy equation (neglecting KE/PE):** $W_{\text{out}} \approx \dot{m}(h_{\text{in}} - h_{\text{out}})$ for an adiabatic turbine. Essentially, the fluid's enthalpy drop is the source of work. (If given per unit mass, $w_{\text{turbine}} = h_{\text{in}} - h_{\text{out}}$.)
- **Isentropic efficiency:** Measures how close the turbine gets to ideal performance. $\eta_T = \frac{\text{actual } \Delta h_{\text{fluid}}}{\text{isentropic } \Delta h_{\text{fluid}}}$ (since actual drop is smaller in magnitude). Rearranged: $h_{\text{out, actual}} = h_{\text{in}} - \eta_T\left(h_{\text{in}} - h_{\text{out, s}}\right)$. The subscript "s" denotes the isentropic exit state (the enthalpy if expansion were ideal to the same pressure).
- **Sign convention:** Make sure to treat work output as positive. If using $W = \dot{m}(h_1 - h_2)$ and $h_2 < h_1$, then W comes out positive, meaning work is produced. If you accidentally swap the enthalpy difference, you'd get a negative result implying work input, which is wrong for a turbine scenario.

Exam Handbook Search Cues (Not affiliated with or endorsed by NCEES): "turbine work", "steady flow energy (turbine)", "isentropic turbine efficiency"

Equation Passport – Turbine Work Equation – relates the **enthalpy drop of a fluid** to the work output from a turbine under ideal conditions:

Name and Purpose: *Steady-Flow Turbine Equation* – calculates the work extracted by a turbine per unit mass of fluid, using the drop in fluid enthalpy between inlet and outlet. It's essentially the first-law energy balance for a turbine (ignoring minor kinetic/potential changes).

Equation (per unit mass):

$$w_{\text{turbine}} = h_{\text{in}} - h_{\text{out}}$$

This gives the work output **per kilogram** of fluid (in J/kg or kJ/kg). For power, multiply by mass flow rate: $W_{\text{shaft}} = \dot{m}\,(h_{\text{in}} - h_{\text{out}})$. An equivalent form sometimes used (for liquids or incompressible flow, like in a hydro turbine) is $w = g\,H$ where H is the head drop, but for general fluids (especially gases/steam), enthalpy is the appropriate term.

Variables and Units:

- w_{turbine} – work output per unit mass (J/kg in SI; in US units could be ft·lb/lbm or BTU/lbm). If multiplied by mass flow $\dot{m}$ (kg/s or lbm/s), you get power (W or ft·lb/s, which can be converted to hp).
- h_{in} – specific enthalpy of fluid at turbine inlet (J/kg or kJ/kg; in BTU/lbm if using US customary)
- h_{out} – specific enthalpy at turbine outlet (same units as h_{in})
- $\dot{m}$ – mass flow rate (kg/s or lbm/s) if you need total power output. *(Not needed for per-unit-mass calculations, but included here to remind how to get absolute power.)*

Assumptions and Scope:

- **Adiabatic, no heat losses:** By assuming the turbine is well insulated (or that heat exchange is negligible during the short residence time of fluid), we set heat transfer $Q \approx 0$. If a problem mentions heat loss, you'd subtract that from $h_{\text{in}} - h_{\text{out}}$, but FE problems usually either neglect Q or incorporate small losses into an efficiency.
- **No significant kinetic or potential energy change:** We assume the fluid's velocity and height change from inlet to outlet are small or designed to be accounted for within h. In a high-speed turbine, kinetic energy might not be negligible, but typically either data is given in enthalpy which already factors in flow work, or the difference is small. If the problem gives velocities, you could use a more general form: $W_{\text{out}} = \dot{m}\left[\left(h_1 + \frac{V_1^2}{2} + gz_1\right) - \left(h_2 + \frac{V_2^2}{2} + gz_2\right)\right]$. Unless explicitly needed, you can ignore ΔKE and ΔPE terms.
- **Single-stream steady flow:** Applies to a steady flow device (one inlet, one outlet) operating in a steady regime. No accumulation of fluid or energy – what comes in goes out plus the work extracted.
- **Ideal expansion (for this equation):** The formula $w = h_{in} - h_{out}$ by itself doesn't require the process to be isentropic; it's true even for actual. It's just energy conservation if we know the actual outlet enthalpy. However, to *find* h_{out} ideally, one would use isentropic relations (e.g. isentropic expansion to P_2 to get $h_{out,s}$). So typically you find ideal $w_s = h_{in} - h_{out,s}$, then adjust for efficiency if needed.

Limit Tests:

- If h_{out} equals h_{in} (no enthalpy drop), then $w_{\text{turbine}} = 0$. That would correspond to a trivial case of no expansion (no pressure drop, or if the turbine is just idling without extracting energy).
- The bigger the difference $h_{\text{in}} - h_{\text{out}}$, the more work per unit mass. For instance, if steam enters with 3000 kJ/kg enthalpy and leaves with 2000 kJ/kg, then $w = 1000$ kJ/kg. If the turbine were more efficient and could leave at 1800 kJ/kg (lower enthalpy because it extracted more energy), w would be 1200 kJ/kg – an increase.

- If you conceptually let P_2 (outlet pressure) approach 0 (vacuum) in a thought experiment, h_{out} would approach the fluid's lowest possible enthalpy (e.g. saturated liquid enthalpy if condensing, or some limit if gas expands infinitely). The work would approach a maximum but real turbines and fluids have practical limits (e.g. condensation, freezing, etc., and ambient pressure). Nonetheless, lower back-pressure yields more h drop and thus more work – which aligns with the equation's implication.
- **Use vs. Sibling Equations:** Use this turbine work relation for any **expander or turbine** where a fluid is dropping in pressure and giving off work. In the same vein, for a **pump or compressor** you'd use $W_{\text{in}} = h_{\text{out}} - h_{\text{in}}$ (work input increases enthalpy), which is essentially the negative of this formula if rearranged. Do not confuse the direction: for turbines, $h_{\text{in}} - h_{\text{out}}$ is positive work output. Also, if dealing with a **hydraulic turbine** (water falling through a height driving a turbine), you might see $W = \rho g H \dot{V}$ (which is analogous: $\rho g H$ is like $h_{in} - h_{out}$ in terms of energy per mass for an incompressible fluid). In all cases, energy out comes from energy drop in fluid.

Common Exam Traps:

- **Sign errors:** It's easy to mix up the enthalpy difference. Some formulas (especially for compressors) are written $W = \dot{m}(h_{out} - h_{in})$ for work input. For turbines, you must do inlet minus outlet to get a positive number (work produced). If you accidentally do $h_{out} - h_{in}$ for a turbine, you'll get a negative work which might confuse you – the magnitude would be correct but sign convention wrong. Stick to $h_{\text{in}} - h_{\text{out}}$ for turbine work output.
- **Mixing units on enthalpy:** Ensure consistency. Often, enthalpies might be given in kJ/kg (especially if from steam tables) but mass flow in kg/s and you want power in kW. That usually works out (kJ/kg * kg/s = kJ/s = kW). If enthalpy is given in BTU/lbm and flow in lbm/s, multiply to get BTU/s, then convert to horsepower or kW as needed (1 BTU/s ≈ 0.7079 hp, since 1 hp = 550 ft·lb/s and 1 BTU = 778 ft·lb). It might be easier to convert BTU to ft·lb or J to avoid confusion.
- **Using average specific heats vs tables:** In many turbine problems (especially involving steam or refrigerants), you'd use tabulated enthalpy values. If the FE exam question provides those, use them directly. If it's an ideal gas (like an air turbine expansion in a Brayton cycle question), they might provide c_p and initial and final temperatures, so you can do $h_{in} - h_{out} = c_p(T_{in} - T_{out})$. But be careful: T_{out} might not be given directly – you might need to compute it for isentropic expansion (using $T_2 = T_1(P_2/P_1)^{(k-1)/k}$ for ideal gas isentropic). Don't use a liquid/solid formula or something irrelevant. Identify the substance and use proper data.
- **Forgetting efficiency when needed:** If the problem gives a turbine efficiency, they usually also give enough info to find the ideal enthalpy drop. For example: "Steam enters at 4 MPa, 400°C and expands to 100 kPa in a turbine with 85% isentropic efficiency. Find the work output." In this case, you'd find h_{in} from steam tables at 4 MPa/400°C, find $h_{out,s}$ at 100 kPa (same entropy as inlet, ideally), then use $\eta_T = \frac{h_{in} - h_{out,\text{actual}}}{h_{in} - h_{out,s}} = 0.85$ to solve for $h_{out,\text{actual}}$. Then $w_{\text{actual}} = h_{in} - h_{out,\text{actual}}$. A common mistake would be to either ignore the efficiency (using full ideal drop) or misuse it (multiplying by efficiency instead of using it as a ratio as above). Always remember for turbines: actual work = efficiency × ideal work.
- **Reheat or multi-stage expansions:** Unlikely on FE exam in detail, but if mentioned conceptually, understand that if fluid is expanded in stages with reheating in between, the total work is more than a single stage without reheat to the same final pressure. That's more of a power plant detail; a conceptual question might ask why reheat increases output (answer: because it allows the fluid to take on more heat and thus enthalpy before expanding further, raising h_{in} of second stage).

Explanation & Analysis: The turbine work equation $W = \dot{m}(h_{in} - h_{out})$ is straightforward – it's basically saying: **the energy per second extracted** equals **mass per second** times **energy per mass lost by the fluid**. Enthalpy is the key property since it encompasses internal energy and flow work (pressure-volume work) for flowing fluids. When a high-enthalpy fluid enters a turbine and a lower-enthalpy fluid exits, the difference has been converted to mechanical rotation of the shaft.

For a quick intuitive grasp, imagine a **hydroelectric turbine**: water at some height (high potential energy) flows down through a turbine to a lower height. The potential energy drop $\Delta PE = g\Delta z$ per unit mass is converted to work. For water, enthalpy change $h_{in} - h_{out}$ can be directly gH if no losses. For a **steam turbine**, instead of height, it's pressure/temperature that drop. Steam at high pressure contains a lot of energy (think of it as "steam pressure pushing on the turbine blades plus hot thermal content"), and when it expands to a lower pressure, it releases that energy. The maximum you could get is if the expansion is isentropic (no entropy gain, hence no energy wasted in disorder/heat). If there's friction or other irreversibilities, the steam will exit with a bit higher enthalpy (meaning it didn't give up as much energy as it could have) – that's why actual h_{out} is higher than ideal $h_{out,s}$, and actual work is less.

On the exam, one approach to turbine problems is to **draw a quick T-s diagram in your mind (or scratch)**: higher inlet state, expanding to some lower pressure. The ideal process is vertical down on the T-s (constant entropy), the actual process curves to the right (increasing entropy). The area under the curve in a T-s diagram represents heat; no area (vertical line) means no heat, ideal. Actual has some area (entropy generated effectively), meaning not all the drop went to work, some went to generating entropy (inefficiency). But you don't need to actually draw T-s in the exam, just recall that $\eta_T = \frac{\Delta h_{\text{actual}}}{\Delta h_{\text{ideal}}}$ is how you apply it.

Let's do a simple number check: Suppose an ideal gas (with constant c_p) expands ideally from 10 bar to 1 bar, starting at $T_1 = 1200$ K. If $k = 1.4$, then $T_{2,s} = 1200 * (1/10)^{(0.4/1.4)} \approx 1200 * (0.1)^{0.2857}$. $(0.1)^{0.2857} = e^{0.2857\ln(0.1)} = e^{0.2857*(-2.3026)} = e^{-0.6579} \approx 0.518$. So $T_{2,s} \approx 1200 * 0.518 \approx 621$ K. If $c_p = 1.0$ kJ/(kg · K) for easy math, then ideal $\Delta h = 1.0 * (1200 - 621) = 579$ kJ/kg. Now if the turbine efficiency is 90%, the actual Δh will be 0.9 * 579 = 521 kJ/kg. That means the actual exit enthalpy corresponds to a higher temperature because less energy was extracted. Indeed, if we assume same c_p, $T_{2,\text{actual}} = 1200 - 521 = 679$ K. That's higher than 621 K – which is consistent with inefficiency (the steam/gas stayed hotter, carrying away the lost work potential). This kind of sanity check ensures you're using

efficiency in the right way: actual work is smaller, so actual T_2 or h_2 is higher than in the ideal case.

In summary, to solve turbine problems in the FE exam: identify states 1 and 2, find h_1 and ideally $h_{2,s}$ for expansion to P_2. Then apply efficiency if needed to get actual h_2. Then apply $W = \dot{m}(h_1 - h_2)$. Often, steam table values or an ideal gas assumption will be given. Be cautious about units (especially mixing kJ and kg vs J and kg, etc.). And conceptually, remember that a **higher turbine efficiency means more energy is converted to work** (good for power output), whereas a lower efficiency means the fluid leaves with more enthalpy than ideal (wasted potential).

K10.T07.S04 – Fans and Blowers (Low-Pressure Air Movers)

Principle Introduction: Fans and blowers are fluid machines like pumps and compressors, but they operate in a different regime: moving **air (or gas) with relatively low pressure increase**. A fan's primary function is to deliver airflow (for cooling, ventilation, etc.) rather than to significantly compress the gas. In fact, in a typical fan or blower, the density of the air doesn't change much from inlet to outlet – we often treat it as incompressible flow for practical calculations. The pressure rise is small (for a fan, maybe only a few inches of water column, or a few percent of an atmosphere). Blowers can achieve a bit higher pressure than fans, but still far below what a compressor does. Think of it this way: **a fan is basically a pump for air**, but because air is light and easily accelerated, fans focus on flow volume with little pressure, whereas compressors focus on pressure increase (with inevitable temperature rise).

In FE exam terms, fans/blowers might appear in qualitative questions or simple power calculations. You should understand that: - **Fan vs Blower vs Compressor:** There's no hard line, but generally fans → move a lot of air at very low pressure rise (pressure ratio usually < 1.1). Blowers → intermediate (maybe up to pressure ratios ~1.2–1.3, like in some industrial blowers or vacuum pumps). Compressors → designed for high pressure ratios (2, 3, 10, or much higher). - **Power and efficiency:** A fan or blower still obeys energy conservation. The useful output is airflow * pressure rise. For a fan, you could estimate **air power** = $Q\Delta P$ (where ΔP is small, Q is large). Fan efficiency η_f would be $\frac{Q\Delta P}{\text{shaft power}}$. In many cases, fan efficiencies are not very high (maybe 50%–70%), and a lot of energy can go into noise and turbulence. - **Applications:** Fans and blowers are everywhere: HVAC systems, car radiators, computer cooling, etc. On the exam, you might get a question like "A blower adds 4 in. H_2O pressure to an airstream of 2000 cfm. If its efficiency is 60%, what horsepower is required?" You'd solve by converting 4 in.H_2O to a pressure (say 4 * 249 Pa, since 1 in.$H_2O \approx 249$ Pa, or use 4 in water ~ 0.144 psi), then use $P = Q\Delta P/\eta$ with Q in appropriate units (convert cfm to e.g. m³/s or ft³/s, etc.). - **Affinity laws (qualitative):** Fans and pumps follow similar scaling laws: e.g., doubling the speed roughly doubles flow, increases pressure by square, and power by cube (the **affinity laws**). While detailed affinity law problems are a separate topic, you might need a conceptual understanding that fans are sensitive to speed changes (e.g., slowing a fan drastically cuts power draw).

Exam Handbook Search Cues (Not affiliated with or endorsed by NCEES): "fan efficiency", "blower power", "affinity laws fans"

Definition Passport – Fan/Blower

- **Plain-language definition:** A **fan** (or blower) is a rotating machine that **moves air or gas with a low pressure increase**. It's designed to circulate or propel air, not to compress it to high pressures. In practical terms, if a device raises the pressure of air by only a few percent of atmospheric pressure, we call it a fan or blower. Fans usually refer to devices for very low pressure rise (like a household fan or computer fan), whereas blowers might produce a bit higher pressure (like in a furnace or inflatable bouncer), but both are far weaker (pressure-wise) than a compressor. They often look like open blades or squirrel-cage designs as opposed to heavy-duty compressor impellers.

- **Where it matters (exam impact):** You'll see fans/blowers in questions related to HVAC, ventilation, or maybe cooling systems, often to compute power or to reason about efficiency. For example, an FE question might give volumetric flow and pressure rise and ask for power (essentially using the $P = Q\Delta P$ relationship and dividing by efficiency). Also, understanding that a fan won't significantly heat the air (since ΔT from such a small ΔP is negligible) can be useful in thermal problems. They might also test conceptually the difference between fan and compressor (e.g., "Why can a fan be treated as an incompressible device?" or "Which device is appropriate for a large volume, low pressure increase application?").

- **Pitfall or confusion point:** One common confusion is **treating a fan like a compressor** – for instance, trying to apply the ideal gas compression formulas to a fan scenario. Don't do that: if the pressure rise is small, the simpler incompressible approach is sufficient (and the exam likely expects that). Another pitfall is the misuse of units when dealing with fan pressure: often given in **inches of water column** or **mm of Hg** etc. These need conversion to Pa or psi for use in formulas. Also, note that fan output is often quoted in terms of "static pressure increase" or "total pressure"; just use the given pressure difference appropriately.

- **Micro-check:** *True or False:* A fan that produces a 0.1 atm pressure rise can be treated as compressing the air significantly (so that air density at the outlet is much higher than inlet). **Answer:** False. A 0.1 atm increase (which is 10% of atmospheric) will cause only about 10% density change if at all – for most fan problems, we consider the density roughly constant and focus on flow rate. Fans are typically analyzed with incompressible flow equations.

Explanation & Analysis:

In essence, fans and blowers sit at the boundary between fluid mechanics and thermodynamics. They involve moving a compressible fluid (air), but under conditions where changes in density are minor. This is why in fluid mechanics courses, fans are often analyzed like pumps (using flowrate and pressure jump), and in thermo courses, compressors are separate (with big density and temperature changes). For the FE exam, if you see a problem about a fan or blower:

Expect to use Power $= \frac{Q\,\Delta P}{\eta}$(the same structure as the pump power formula $\frac{\rho g Q H}{\eta}$, because $\rho g H$is just another way to write pressure difference ΔPtimes a fluid volume weight, etc.). For air, you might directly use ΔPgiven. Make sure to use consistent units (if $Q$is in cubic feet per minute and ΔPin inches of water, convert both to SI or both to a consistent imperial set). A handy conversion: 1 in. $H_2O \approx 249$ Pa(or 0.0361 psi). So 4 in. $H_2O$is about 996 Pa. If $Q = 2000$ cfm(cubic feet per minute), convert to $\approx 0.944\ \text{m}^3/\text{s}$, or in ft^3/sthat's 33.3 ft^3/s. Then air power $Q\,\Delta P = 33.3\ \frac{\text{ft}^3}{\text{s}} \times \left(4 \times 5.2\ \frac{\text{lb}}{\text{ft}^2}\right)$ (since 1 in. $H_2O \approx 5.2\ \text{lb/ft}^2$) $= 33.3 \times 20.8 \approx 693\ \text{ft} \cdot \text{lb/s}$. Divide by 550 to get horsepower: ≈ 1.26 hpof air

power. If efficiency is 60%, shaft power $= 1.26/0.6 \approx 2.1$ hp. This is the kind of straightforward calculation you might do. The key is recognizing the relevant formula and converting units properly.

- Another conceptual aspect: Fans often have performance curves and follow affinity laws. For instance, if you reduce a fan's speed to half, flow Qroughly halves, pressure rise drops to a quarter (since $\Delta P \propto N^2$with Nspeed), and power drops to one-eighth ($P \propto N^3$). The exam might not ask you to derive that, but it could ask something like "If a fan's speed is increased by 10%, what happens approximately to its power draw?" (Answer: increase by about 33%because $(1.1)^3 \approx 1.331$). So remember the cube law for power in fans/pumps. It's also a reason why slowing fans saves a lot of energy (useful in engineering design).
- Fans and blowers usually don't have a dramatic effect on fluid temperature. The pressure rises are so low that any temperature increase $\left(\Delta T \approx \frac{\Delta P}{\rho c_p}\right)$is small. For example, raising air pressure by 50 Pa (which is 0.00725 psi) in a building ventilation fan might cause a temperature rise of maybe a fraction of a degree at most. So you can often treat it as an isothermal process for the air. This is opposite of compressors, which definitely heat the gas up. So a potential exam question: "Why can fans often be analyzed ignoring air temperature change?" Because the pressure increase (hence compression) is minimal, so the process is effectively incompressible and any heating is negligible.
- One quirky note: sometimes the terms blower and fan are used interchangeably, but "blower" can imply a ducted fan or one that can develop a slight pressure (like to blow through a system with some resistance). A vacuum cleaner or a leaf blower has more "pressure" capability than a simple desk fan, so those might be called blowers. In engineering, we might say blowers achieve perhaps up to tens of kPa pressure rises at most, whereas compressors easily go hundreds or thousands of kPa.

In summary, from an exam perspective, treat fans and blowers like low-pressure pumps: compute power with $Q\,\Delta P$, apply efficiency, watch your units, and conceptually understand they do not change fluid density significantly. And if you are asked to distinguish them from compressors: fans/blowers = large volume, low pressure; compressors = smaller volume, high pressure (with significant heating). That distinction can be the key to picking the right formula or concept in a fluid mechanics question about power and efficiency.

Topic 08 - Performance Curves

Topic 08 Introduction: *Performance curves* are the graphical "fingerprints" of pumps and fans, showing how these machines behave under varying flow conditions. On the FE Mechanical Exam, you'll encounter questions where you must interpret these curves or apply scaling laws to predict performance changes. Knowing how to read a pump's head vs. flow rate graph, find a system operating point, or use the fan affinity laws can quickly guide you to the correct answer. This topic matters because it connects theory to real-world selection: you're essentially ensuring that a pump or fan can deliver the required flow *and* understanding what happens if conditions change (like a speed increase or a higher pipe resistance). Typical exam problems include finding the flow rate at the intersection of a pump curve and a system curve, calculating the horsepower needed for a pump at a given operating point, or determining new flow/pressure when a fan's speed changes. In short, mastering performance curves means you can predict and control fluid systems – a skill examiners love to test.

K10.T08.S01 – Characteristic Performance Curves of Centrifugal Pumps

Principle Introduction: Centrifugal pump performance is summarized by a set of characteristic curves measured at a given pump speed and impeller size. These curves plot key outcomes against flow rate (Q):

- **Head vs. Q:** The *head* (energy per unit weight, often in feet or meters of fluid) the pump can provide typically **decreases as flow increases**. At zero flow (shutoff), the pump achieves its **maximum head** (all energy goes into pressure). As flow rises, the pump can sustain less head due to increased fluid movement and internal losses.
- **Efficiency vs. Q:** Pump efficiency (η) is **zero at both zero flow and at excessive flow**, with a **peak at an intermediate flow**. This peak is the **Best Efficiency Point (BEP)** – the flow rate where the pump operates most effectively. Running near the BEP is ideal for longevity and energy use.
- **Power vs. Q:** The shaft power required (often in horsepower or kW) **increases with flow rate**. Little flow means little work done on fluid, but the pump still draws power to maintain pressure (inefficiency). As flow increases, the pump does more work on the fluid (and efficiency improves up to BEP), so the input power rises to a maximum toward the high end of the curve. In practice, a pump motor must be sized to cover this highest power demand at maximum flow.
- These curves are unique to each pump (or pump family) and are usually provided by the manufacturer. They assume a specific **rotational speed and impeller diameter** – changing those will shift the curves (addressed by affinity laws later). They also assume a certain fluid (usually water at standard density); using a fluid with different density affects power but head curves are typically given in length units to remain independent of fluid density.

Exam Handbook Search Cues (Not affiliated with or endorsed by NCEES): *centrifugal pump curve, head vs flow, pump efficiency, pump power, performance curve*

Footnotes:

- *Units:* Head (H) is typically given in length (ft or m of fluid). This is advantageous because head in feet or meters is independent of fluid density – it directly tells you how high the pump can lift *that fluid*. To convert head to a pressure increase Δp, use $\Delta p = \rho g H$ (so a pump that adds 10 m of head to water produces about 98,100 Pa of pressure rise). Flow rate (Q) might be in m^3/s, L/s, or in US units often gallons per minute (GPM). Power (P) is usually in horsepower (hp) or kilowatts (kW) on pump curves. Be mindful to convert flow units to consistent units if you plug into formulas (1 ft^3/s = 448.8 GPM, for example).
- *Symbols:* H for head, Q for flow, P for power, and η for efficiency are standard. Efficiency is expressed as a decimal (e.g. 0.70 for 70%). Occasionally charts include $\boldsymbol{NPSH_R}$ (Net Positive Suction Head Required) vs Q – that curve indicates the suction head needed to avoid cavitation; while important for pump selection, NPSH is typically a separate consideration and appears on the same chart but doesn't affect the head/efficiency/power relationship directly.
- *Scope:* These curves assume **steady, incompressible flow** of a single-phase fluid (usually liquid water). They apply to **centrifugal pumps** (which impart energy via spinning impeller). Other pump types (like positive displacement pumps) have very different performance behavior (e.g. near-vertical head vs Q curves), but those are beyond the scope of this topic. Always check that the question is referring to a centrifugal pump (common in FE exam scenarios).
- *Hidden assumptions:* The curves are measured at a fixed impeller diameter and rotation speed. If you change the pump speed (RPM) or trim the impeller, the curves will shift – use affinity laws (coming up) to estimate the new performance. Also, the efficiency curve assumes the pump is in good condition and properly primed; real-world issues like wear or air entrainment can lower efficiency, but exam questions will assume ideal catalog performance unless stated otherwise.

Variations and Related Forms: For a given pump, you might see multiple head–flow curves on one graph, each for a different **impeller diameter** or different speed. For instance, manufacturers often provide a family of curves: larger impellers give higher head at a given flow. The shape remains similar (all curves droop downward with Q) but a trimmed (smaller) impeller yields lower head and usually slightly lower max flow. Likewise, multiple **horsepower lines** may be drawn to indicate the power consumption for various motor sizes – ensuring the selected motor can handle the curve up to its end. In general, **typical values**: centrifugal pumps can often reach efficiencies in the 60–85% range at BEP. The shutoff head might be on the order of 1.1 to 1.3 times the head at BEP flow (just a rough rule; exact shape depends on design). Beyond the recommended operating range (too far left or right of BEP), pumps may vibrate or overheat, which is why curves sometimes mark a minimum or maximum flow limit. For exam purposes, remember that the **general trend** (head down with Q, efficiency peak, power up with Q) holds for virtually all centrifugal pumps.

Special Notes (calculator usage): When using the exam-approved calculators to compute pump power or other quantities from these curves, break the calculation into pieces to avoid confusion. For example, to compute power from $W = \frac{\rho\, g\, Q\, H}{\eta}$, it's wise to compute the numerator $\rho\, g\, Q\, H$ first, then divide by η. Ensure that you enter efficiency as a decimal. Also, watch unit conversions: if Q is given in GPM and H in feet, one convenient formula for water is $W_{\text{hp}} = \frac{\gamma Q(\text{ft}^3/\text{s}) H(\text{ft})}{550\ \eta}$, where $\gamma = 62.4\ \text{lbf/ft}^3$ and 550 (ft·lbf/s) is 1 hp. It might be easier to convert flow to ft^3/s and use γ directly. All the allowed calculators (Casio, HP, TI models) can handle these calculations well – just be careful with parentheses and use the memory/register if needed to store intermediate results like $\rho\, g\, Q\, H$. A quick mental check is valuable: if efficiency is less than 100%, your required input power must be higher than the ideal fluid power $\rho\, g\, Q\, H$. For instance, if a pump needs to raise 0.05 m³/s by 20 m (against water, ρ≈1000 kg/m³), $\rho\, g\, Q\, H \approx 10009.810.05 * 20 \approx 9810\ W$ of fluid power. If the pump is 70% efficient, actual shaft power $W \approx 9810/0.7 \approx 14{,}014$ W (about 14 kW). Always expect the input to be larger than output due to η<1.

Explanation & Analysis: The pump's performance curves essentially answer the question: *"If I operate this pump at a certain speed, what head will it produce at flow Q, how efficient will it be, and how much power will it draw?"* Exam problems on this subtopic often give you a pump curve (or data from it) and ask you to find an operating point or compute power or efficiency at a given condition. To use the curves, first identify the given flow or head in the problem, then read the corresponding values: for example, if a question says "A pump delivers 500 GPM at 40 ft of head," you might be expected to determine the efficiency from a provided graph or calculate power. **Physically**, head represents the pump's ability to increase fluid pressure or elevation. Each point on the head vs Q curve is a balance between the impeller's energy transfer and the resistance of moving fluid: at higher Q, the impeller imparts less head because the fluid has less time in the impeller and friction losses inside the pump increase. Efficiency is highest at the BEP because that's where flow patterns inside the pump are optimal (minimal recirculation and losses). At zero flow, efficiency is 0% (no water delivered, so no useful work output, even though the pump is pressurizing fluid); at very high flow, efficiency drops again because losses skyrocket and the pump can't keep up with flow demands. **Term by term, using the pump power equation $W = \frac{\rho\, g\, Q\, H}{\eta}$:** $\rho\, g\, Q\, H$ is the **fluid power** (the rate of gain of potential energy by the fluid). For water, $\rho\, g \approx 9.81\ \text{kN/m}^3$, so $Q\, H$ in units of m³/s and m gives J/s (Watts). η (dimensionless, <1) accounts for the fact that the pump isn't 100% efficient; dividing by η gives the larger input power required. Common mistakes include **unit mix-ups** (forgetting to convert Q to m³/s or ft³/s, using g = 9.81 in US units without converting to consistent units, etc.) and using the efficiency as a percent in the formula. Always double-check units: write out one unit example if unsure (e.g., in US units: $\rho\, g\, Q\, H$ yields ft·lbf/s, divide by 550 to get horsepower, and divide by efficiency). Also, note the difference between **brake (shaft) power** and **fluid (water) power**: the latter is $\rho\, g\, Q\, H$, the former is higher due to inefficiency. The exam might directly give efficiency and ask for brake horsepower, or vice versa ask for output water power. One more check: as $Q \to 0$, the formula $\rho\, g\, Q\, H$ goes to 0, so ideal required power → 0; but in reality, pumps at shutoff still draw some power because $\eta \to 0$ (lots of internal loss). Conversely, as Q increases to the pump's maximum (where $H \to 0$), $\rho\, g\, Q\, H$ also→0, implying little useful output – again efficiency plummets, so actual power doesn't drop to zero. These limits are reflected by the efficiency curve touching zero at both ends. In summary, use the performance curves to find the **operating sweet spot** of a pump and to ensure the pump can meet the system's requirements without overloading the motor. On the exam, if you see a question involving a pump curve, systematically identify the given point on the curve, then extract the needed info (head, efficiency, power) from the graph or using the provided data and formula. Remember: **pump curves + system curves = operating point**, which is exactly our next subtopic.

K10.T08.S02 – System Curve and Pump Operating Point

Principle Introduction: A *system curve* describes the relationship between flow rate and required head for a particular piping system. It answers, *"How much head do I need from a pump to push Q flow through my system?"* Key characteristics of the system curve include:

- **Static Head and Flow-Dependent Head:** If the system involves lifting fluid to some elevation, there is a **static head** requirement (e.g. 20 ft of lift) that is needed even at zero flow. On top of that, **frictional head loss** in pipes/fittings increases with flow (approximately with Q^2 for turbulent flow). Thus, the total head required by the system can often be expressed as $H_{\text{sys}}(Q) = H_{\text{static}} + kQ^2$ (for some constant k that depends on pipe lengths, diameters, roughness, etc.). At $Q = 0$, $H_{\text{sys}} = H_{\text{static}}$ (you still have to lift to the reservoir, for example, even if no water is moving). As Q grows, friction losses make H_{sys} climb quadratically.
- **System Curve on a Graph:** When you plot H_{sys} vs. Q, you usually get a rising curve (often starting at the static head at zero flow and curving upward as Q increases). It's typically a gentle upward bend if dominated by friction (parabolic shape) or a flat line if only static head (no friction losses). Each piping system has its own unique curve depending on elevation change and resistance.
- **Operating Point (Intersection):** The **operating point** of a pump-system combo is where the pump's capability meets the system's demand. In other words, it's the intersection of the pump's head vs Q curve and the system's $H_{\text{sys}}(Q)$ curve. At this point, **pump head = system required head** and the flow is exactly what the system will carry. This is a balance: if the pump tries to push more flow than this, the system's required head rises above what the pump can provide, so flow settles back. If the pump provides less, the system head requirement drops and the pump can increase flow. Thus, the system naturally operates at the intersection.
- **Multiple Operating Points or Conditions:** Generally, for a given fixed-speed pump and static system, there is a single stable operating point. However, if you have a variable restriction (like a throttling valve) or multiple pumps, the system curve can change. For example, *closing a valve* steepens the system curve (increasing resistance), which will move the intersection to a lower flow/higher head point on the same pump curve. Conversely, *opening a valve* or using a larger pipe flattens the system curve (less resistance), shifting the intersection to higher flow. These concepts underline why pumps have a range: you can adjust the system and the pump will slide along its curve to a new operating condition.
- **Why It Matters:** On the FE exam, you might be asked to find the flow rate given a pump curve and system head equation, or vice versa to find required pump head for a

desired flow. Understanding that you solve it by equating pump head = system head is the key insight. Graphically, you'd find where the two curves cross; algebraically, you set the pump's head equation (or value from its curve) equal to $H_{\text{sys}}(Q)$ and solve for Q.

Exam Handbook Search Cues (Not affiliated with or endorsed by NCEES): *system head curve, operating point, pump-system intersection, static head, friction loss*

Footnotes:

- *System Head Formula:* The generic system curve formula $H_{\text{sys}} = H_{\text{static}} + \frac{v^2}{2g}\sum K$ comes from the energy equation. Here $\sum K$ represents the total loss coefficient of pipes and fittings, and v is flow velocity. Since $Q = A\,v$, this can be rewritten as $H_{\text{sys}} = H_{\text{static}} + C\,Q^2$ for some constant C (in appropriate units) when flow is turbulent. If flow were laminar (rare in large-scale water systems, but maybe in small passages), head loss would scale with Q^1 (linear), but most often you'll assume turbulent Q^2 behavior unless told otherwise. Remember to use consistent units: if using $v^2/(2g)$, v is in m/s, g = 9.81 m/s², yielding head in meters; in US units, v in ft/s, g = 32.174 ft/s² for head in feet.
- *Static Head Nuances:* H_{static} is the elevation difference (plus any required pressure increase at the outlet if, say, you need a certain pressure at a nozzle). On a system curve graph, it's the intercept at Q=0. If a system has *no elevation gain* (just circulating flow in a loop), then $H_{\text{static}} = 0$ and the system curve starts at the origin – meaning if the pump is off, no head is needed (no flow anyway). If there is a reservoir or height to overcome, that's a fixed cost in head.
- *Pumping vs. Generating:* We typically draw system curves for pump systems where you *add* head. In some cases like turbine systems (water flowing down through a turbine), you might have an analogous concept where the system can provide head and the machine consumes it – that's beyond our scope here, but just note that those would invert some thinking. For the FE exam, stick to pump scenarios.
- *Multiple Pumps:* If two pumps are in **series** (one after the other), effectively their head adds for a given flow – the pump curve shifts upward (you add their heads at each Q). If pumps are in **parallel** (side by side feeding the same system), their flows add for a given head – the pump curve extends to higher Q (adding flow at each head). These composite curves then intersect the system curve for a new operating point. Know that series pumps boost head, parallel pumps boost flow capacity. While not always explicitly asked under "performance curves," this is a logical extension if you see a problem about multiple pumps achieving a certain flow/head.
- *Unstable operation:* If a pump curve dips down and then up (rare for centrifugals, more common in certain turbines or two-flow-region pumps), there could be two intersections with a system curve, one unstable. Usually exam problems avoid such complexity – assume a nice monotonic pump curve so the intersection is unique.

Variations and What-If Scenarios: Once you have the operating point, you can explore how changes affect it. **Throttle the flow**: closing a valve (adding resistance) makes the system curve steeper (higher C), moving the intersection left (lower Q, higher H) – effectively "choking" the flow. **Change pump speed or impeller**: the pump curve will move (using affinity laws, next section) – a slower pump produces less head and flow, so the intersection moves down and left; a faster pump moves up and right. **Add another pump in parallel**: the combined curve can supply more flow at the same head, potentially shifting operating point to higher Q if the system can take it. On the exam, a common variation is: "The system curve is given by $H = H_s + kQ^2$. If a pump's characteristic is $H_{\text{pump}} = H_0 - mQ^2$ (for example) and you double the flow, how much does system head increase?" or conversely "what happens if two identical pumps are used?" Remember series adds head, parallel adds flow. Also, **typical values**: Many practical piping systems have a modest static head (a few meters or tens of feet) and then friction that becomes significant at high flows. If static head >> friction head at normal flow, the system curve is relatively flat (mostly dominated by lift). If static head is zero and long pipes dominate, the curve goes through origin and can become quite steep at high Q.

Special Notes (exam tips): If you need to solve for the operating point algebraically, you'll set pump head equal to system head. Sometimes a quadratic equation results. You can solve that by hand or use the calculator's solve feature if available (Casio fx-115 ES has a polynomial solver, HP 35s can solve via programs or iterative, TI-36 has solve as well). If you don't have a solver, it might be easiest to plug in answer choices to see which one satisfies both equations (if it's a multiple-choice exam). Graphical estimation is also useful: understand qualitatively if the operating point should be closer to the pump's shutoff (if system requires a lot of head) or closer to free flow (if system is low resistance). Also, ensure you interpret "head" vs "pressure" correctly: if a problem gives pressures, convert them to head for comparison with the pump curve (using $H = \Delta p/(\rho g)$) unless the pump curve is also given in pressure units. Finally, when dealing with multiple pumps or variable speed, sketch mini-curves: it helps prevent mistakes. One quick check: if you accidentally set them equal wrong (e.g. add heads when you should equate, etc.), your answer might violate energy conservation or be obviously unreasonable (like predicting higher flow through a more resistive system – a red flag).

Explanation & Analysis: The **operating point** concept is essentially Newton's method in fluids: the pump can only provide so much head, and the system will only accept a flow if that much head is provided – so the two negotiate a balance. On exam day, remember that *no pump will force more flow than the system allows*. If a question asks "will the pump be able to deliver X GPM to a tank elevated Y ft above?" you figure it out by checking if the pump can generate Y ft of head at that flow (from its curve) – if yes, flow will be something; if no, the pump will actually stall at some lower flow where head matches. Each symbol in the system curve equation has physical meaning: H_{static} [m or ft] is purely elevation or pressure head needed before any flow can happen; the kQ^2 term (with Q in e.g. m³/s and k in appropriate (m or ft)/(m³/s)^2 units) encapsulates pipe friction, which grows with flow squared. In analysis, if Q doubles, frictional head requirement quadruples (since $(2Q)^2 = 4Q^2$). Static head, however, doesn't change with Q. A common pitfall is to forget the static head when flow is zero – some assume zero flow means zero head loss, which is true for friction but not for lifting height. Another pitfall is confusion between **system curve** and **pump curve**: remember the pump curve is a property of the machine (usually provided), and the system curve is determined by the piping. The intersection formula can be derived from energy equations, but on the exam, you usually don't need to derive – you just need to apply it. If a problem gives a formula or graph, use it directly. For example, if pump curve is

$H = 60 - 0.01Q^2$ (with Q in e.g. L/s and H in m) and system is $H = 20 + 0.02Q^2$, set $60 - 0.01Q^2 = 20 + 0.02Q^2$. Solve: $60 - 20 = 0.02Q^2 + 0.01Q^2$, $40 = 0.03Q^2$, so $Q^2 = 1333.3$, $Q \approx 36.5$ (L/s). Plug that back to get head ~ $60 - 0.01(1333) = 60 - 13.33 = 46.7$ *m (which should match* $20 + 0.021333 = 20 + 26.67 = 46.7$ m indeed). That's the operating point (36.5 L/s at 46.7 m head). If you were to increase the static head to, say, 30 m, re-do: $60 - 0.01Q^2 = 30 + 0.02Q^2$ leads to $30 = 0.03Q^2$, $Q^2 = 1000$, $Q = 31.6$ L/s and head ~ $60 - 0.011000 = 50$ *m (which equals* $30 + 0.021000 = 50$ m). Less flow because the system demanded more head – exactly as expected. The takeaway: find the equilibrium by equating head from pump and system, and interpret shifts logically. This guarantees you'll find the correct operating conditions and not propose something unphysical (like a pump delivering more flow than it can or a system magically using less head than gravity says it must). Mastering this is crucial for fluid systems design and very testable on the FE exam.

K10.T08.S03 – Fan Performance Curves and Affinity Laws

Principle Introduction: *Fans* are essentially pumps for air (or gases): they impart pressure rise to move air through ducts or systems. Their performance curves look similar in concept – usually plotting **pressure rise (ΔP)** or **head** vs. **flow (Q)** – but typically at various speeds. Because fans (and pumps) often need to operate over a range of speeds or sizes, we use the **affinity laws (fan laws)** to predict performance changes. Key points for this subtopic:

Fan Curve (Pressure vs. Flow): At a given fan speed (RPM), a typical fan has a curve of pressure rise vs. flow that **decreases with increasing flow** (just like a pump's head vs Q curve). For a centrifugal fan or axial fan, at zero flow the fan builds maximum pressure (stall or shutoff pressure), and at higher flow the pressure rise drops to zero at some maximum flow (free delivery, where the fan just moves air with no resistance). Often, fan performance is given in terms of **static pressure** rise (excluding velocity pressure at outlet) or **total pressure** rise; for exam problems, the distinction is usually minor unless specified. The fan will have a **peak efficiency** at a certain flow as well, analogous to pump BEP, but fan efficiency is often lower (maybe 50–70%) and is sometimes not emphasized in basic problems.

Effect of Speed – Affinity Laws: If you change the rotational speed (N) of a fan (or pump) without changing its geometry, the performance curve scales in a predictable way: **Flow capacity ∝ N**, **Pressure (or head) ∝ N²**, and **Power ∝ N³**. In other words, increasing speed makes the fan capable of delivering proportionally more flow and a squared increase in pressure rise. These are part of the affinity laws:

- $Q_2/Q_1 = N_2/N_1$ (flow scales linearly with speed for same fan)
- $\Delta P_2/\Delta P_1 = (N_2/N_1)^2$ (pressure rise or head scales with the square of speed)
- $P_{\text{shaft},2}/P_{\text{shaft},1} = (N_2/N_1)^3$ (required shaft power scales with the cube of speed) These assume the fan is handling the same fluid (same density) and operating in the same flow regime (usually turbulent, Reynolds similarity).

Effect of Size – Affinity Laws: Similarly, if you scale the fan's size (impeller diameter D) while keeping tip speed proportional (and same flow patterns), the laws are: **Flow ∝ D³** (because a larger fan moves more volume), **Pressure ∝ D²**, **Power ∝ D^5** (since power ∝ flow * pressure ∝ D³ * D²). Combined with speed changes, the general affinity laws for two geometrically similar cases (subscript 1 and 2) are:

- $Q_2/Q_1 = (N_2/N_1)\,(D_2/D_1)^3$
- $\Delta P_2/\Delta P_1 = (N_2/N_1)^2\,(D_2/D_1)^2$
- $P_2/P_1 = (N_2/N_1)^3\,(D_2/D_1)^5$. The exam most often deals with speed changes on the *same machine* (so D constant), which simplifies these to the N relationships above. But if, say, a question involves "a model pump vs a prototype pump," you might need the diameter factors too.

Family of Curves: Because of affinity laws, manufacturers often present a **family of fan curves** at different speeds. For example, a chart might have pressure-vs-flow curves for 1000 RPM, 1500 RPM, 1800 RPM, etc. They don't test each speed separately; instead, these curves are related by the laws. If you know one curve, you can sketch or compute another. The shape remains similar, just stretched to higher flow and pressure for higher speeds.

When to Use Fan Laws: The fan (affinity) laws are extremely useful for exam problems like: "A fan delivers 500 CFM at 2 in. H_2O static pressure with a 1 hp motor at 1200 RPM. Estimate the flow and pressure if sped up to 1500 RPM (same fan, same system). Also, what motor power is needed?" You would use the ratios: $Q_2 = Q_1(1500/1200)$, $\Delta P_2 = \Delta P_1(1500/1200)^2$, and $P_{shaft,2} = P_1 * (1500/1200)^3$ to get the answers. They allow quick scaling without complex re-testing.

Definition/Note Passport: Affinity Laws (Fan/Pump Scaling)

- **Plain-language definition:** *Affinity laws* are a set of proportional relationships that predict how a pump or fan's performance (flow rate, pressure/head, power) changes when speed or size changes. Essentially, "how much more flow or pressure will I get if I spin this fan faster or build it larger?"

- **Where it matters (exam impact):** These laws show up in questions about **variable-speed pumps/fans** or **scale models**. On the FE Exam, expect to apply them for quick estimates: e.g., increasing a pump's RPM by 20% will increase its flow by 20%, head by 44% (since $1.2^2 = 1.44$), and power by 73% ($1.2^3 \approx 1.73$ or 73% increase). They simplify what would otherwise require detailed fluid dynamics analysis.

- **Pitfall or confusion point:** A common mistake is using the wrong exponent with the wrong quantity (mixing up which law applies to flow vs pressure vs power). Another is forgetting to adjust for **fluid density**: the pressure scaling strictly holds when handling the same fluid. If the density changes (e.g., a fan at altitude where air is less dense), the pressure rise at a given speed will actually drop proportionally to ρ. Some affinity law formulations include density ratio: $\Delta P_2/\Delta P_1 = (\rho_2/\rho_1)(N_2/N_1)^2$ *and similarly* $P_2/P_1 = (\rho_2/\rho_1)(N_2/N_1)^3$ for the same fan in different air densities. Unless the problem explicitly mentions a change in gas or altitude, assume density constant. Finally, ensure you keep units consistent (the ratio form helps because units cancel, but if you plug actual numbers, say RPM in both, it's fine as a pure ratio).

- **Micro-check:** *True/False:* Doubling a pump's speed will double the flow it can produce *and* require roughly eight times the shaft power. **True.** (Flow ~×2, Power ~×2³ = ×8, assuming the pump isn't at its limits and efficiency stays similar.)

Exam Handbook Search Cues (Not affiliated with or endorsed by NCEES): *fan laws, affinity laws, fan performance, speed scaling, pump affinity*

Footnotes:

- *Dimensional consistency:* The beauty of affinity laws is that they use ratios, so you don't need to convert e.g. RPM into rad/s or diameter into meters – as long as you use the *same units* in the ratio, the factor works out. For example, if $N_1 = 1200$ RPM and $N_2 = 1800$ RPM, use 1800/1200 = 1.5 in the formulas. If diameters are 8 inch vs 6 inch, use 8/6 = 1.333. The resulting Q_2/Q_1 is dimensionless (like 1.333^3 for the diameter effect on flow). This also implies you can mix units for different terms as long as each ratio is homogeneous (though it's best not to mix unintentionally).
- *Efficiency assumption:* The affinity laws assume the efficiency of the machine remains about the same at both conditions. In reality, very large speed changes can shift the operating point away from the best efficiency point, and efficiency might drop. The exam usually ignores that nuance unless they specifically mention efficiency changes. So apply the laws assuming constant efficiency unless told otherwise. If a problem says a fan draws 2 kW at one condition and asks for power at a new condition, implicitly they expect you to use the cubic law, which assumes similar efficiency.
- *Limits:* Affinity laws are based on **similarity**. If you try to scale outside reasonable bounds (e.g., predicting that doubling speed will double flow – that works until maybe the flow becomes choked or the motor can't provide 8× power or the flow regime changes), the laws eventually break down. But in the moderate ranges typical in exam problems, they hold well. Also, if a system curve is present, don't forget that the actual new operating point will be where the new pump/fan curve intersects the system curve. Sometimes students apply affinity laws to free delivery (max flow) thinking that's the new operating flow regardless of system – that's incorrect. If the exam problem provides a system or operating point, scale the *whole operating point*: e.g., at 1200 RPM the fan gave 500 CFM at 2 in. pressure; at 1500 RPM the fan's curve suggests ~625 CFM at 3.12 in. (via laws), but the actual flow might be slightly different if the system resistance also increased with flow. However, usually the question assumes either a free delivery scenario or asks for the new capability, not accounting for system resistance changes unless they explicitly give a system equation.
- *Fan vs Pump Terminology:* "Fan laws" and "pump affinity laws" are the same concept. The exam may use either term depending on context (HVAC problems might say fan laws, fluid machinery might say pump affinity). Don't get confused – they are interchangeable principles.

Explanation & Analysis: Let's walk through a typical scenario to solidify the fan affinity laws. Suppose a fan delivers 10,000 cubic feet per minute (CFM) of air at a pressure increase of 2 inches of water column (in. wg) while spinning at 1000 RPM and consuming 5 hp. Now, the question asks: *if we speed it up to 1200 RPM, what are the new flow, pressure, and power (assuming the same system or free delivery)?* Using affinity laws: $N_2/N_1 = 1200/1000 = 1.2$. So, $Q_2 = 1.2 * 10{,}000 = 12{,}000$ CFM (20% higher flow), $\Delta P_2 = (1.2)^2 * 2 = 1.44 * 2 = 2.88$ in. wg (pressure rises by 44%), and $P_{shaft,2} = (1.2)^3 * 5 = 1.728 * 5 \approx 8.64$ hp (power goes up 73% to meet the higher load). These numbers make sense physically: more speed = more flow and disproportionately more pressure, requiring a lot more power. Now, analysis: each equation corresponds to a physical relationship. $Q \propto N$ because essentially, if the fan spins faster, it sweeps a larger volume of air per time in direct proportion. $\Delta P \propto N^2$ because pressure is related to the air's velocity head ($\sim \frac{1}{2}\rho v^2$) and if you spin 20% faster, the tip speed and air velocity go up 20%, so kinetic energy per volume (pressure) goes up $(1.2)^2 = 1.44$ times (since kinetic energy ~ v^2). $P \propto N^3$ because power = flow * pressure (in simplest terms), so combining $Q \propto N$ and $\Delta P \propto N^2$ gives $P \propto N^3$. In terms of symbols: N is speed (rpm), Q is flow (CFM or L/s or m³/s), ΔP could be in Pa or in. H_2O or ft head – any pressure unit, it's the ratio that matters, and P (power) maybe in hp or kW. The relationships assume the fluid's density ρ stays constant; if not, include the ratio ρ_2/ρ_1 for pressure and power as noted.

Common traps: forgetting that these are *ratios* (you can't just multiply 1200 RPM by something to get pressure; you must apply to an initial known condition), and confusing what stays constant. For example, sometimes a problem might implicitly hold one variable constant: "If you change a fan from 60 °F air to 100 °F air (density drop) at the same speed, what happens to flow and pressure?" Flow would stay same (same fan, same rpm, it will deliver roughly same volumetric flow if system allows) but pressure would drop due to lower density (less mass per volume to throw around, so less force). That's an edge case application. In most cases, you'll straightforwardly apply the power-square-cube laws to scale performance **up or down in speed or size**. Another point: ensure you apply the laws about the *same point on the performance curve.* That means if the fan was at a certain percentage of its max flow, after scaling it will be at that same percentage of its new max. If the question describes operation at a certain system point (like 2 in. at 10k CFM), scaling speed gives a new fan curve, but the system curve might intersect at a different relative point. However, the exam usually either keeps the system the same (so you find a new intersection using both the fan laws and system equation) or assumes free/unrestricted flow. If needed, you might combine the system curve equation with the fan laws: e.g. $\Delta P \propto N^2$ for fan and $\Delta P \propto Q^2$ for system (since for a fixed system, required $\Delta P \sim Q^2$). Setting those equal at new condition can solve for new Q by: $\frac{\Delta P_2}{\Delta P_1} = (N_2/N_1)^2$ (fan) and also $\frac{\Delta P_2}{\Delta P_1} = (Q_2/Q_1)^2$ (system). Equate: $(N_2/N_1)^2 = (Q_2/Q_1)^2$, so indeed $Q_2/Q_1 = N_2/N_1$ (consistent with the affinity law for flow). This consistency check shows that if the same system is imposed, increasing fan speed by 20% will indeed increase flow by 20% (because the system curve's resistance and fan's new capability balance out exactly there). Thus, you could get the same answer by just applying $Q \propto N$ directly – which is simpler. All roads agree if done correctly. In summary, **fan performance curves** let you find operating points and efficiency at one speed, and **affinity laws** let you scale those results to new speeds or sizes quickly. Keep these laws handy; they're quick wins on exam problems: just plug the ratios and exponentiate. With these, you can confidently tackle questions about pumps or fans running faster, slower, or being scaled up, without having to derive from scratch. Remember to double-check the exponent matching (e.g. don't accidentally cube the flow or square the power) – if you're unsure, derive dimensionally: power = flow * pressure, and see that ($N^1 * N^2 = N^3$) logic one more time. With practice, it becomes second nature.

Topic 09 - Scaling Laws for Fans, Pumps, and Compressors

Topic Introduction: This chapter covers how the performance of turbomachines (like fans, pumps, and compressors) scales with changes in size or speed. On the FE Mechanical Exam, you may face questions asking how a pump's flow rate or head changes if you adjust its rotational speed, or how to use a scaled model's test data to predict a full-size machine's performance. The key tools here are the **affinity laws** (similarity laws), which relate flow, head (or pressure), and power between geometrically similar operating points. We also lean on **dimensionless parameters** (especially the Reynolds number) to ensure model tests truly reflect prototype behavior. Mastering these concepts will allow you to quickly scale known performance data to new conditions – a common need in exam problems involving fans, pumps, or compressor performance adjustments.

K10.T09.S01 – Affinity Laws for Turbomachinery (Fans, Pumps, Compressors)

Principle Introduction: The affinity laws describe how key performance measures scale when you change a machine's **rotational speed (N)** or **impeller size (D)**, assuming the machine's shape and fluid remain the same. These laws are derived from similarity principles and are fundamental for predicting new operating points:

- **Geometric similarity required:** The machine's shape (blade angles, impeller design) is the same; only scale (size) or speed changes. Under these conditions, flow, head, and power follow fixed exponent relationships with **N** and **D**.

- **Flow rate** increases linearly with speed and to the **third power** with size. **Head (or pressure rise)** increases with the **square** of speed and the **square** of size. **Power** (the rate of work done on the fluid) increases dramatically – with the **cube** of speed and the **fifth power** of size.

- **Simple example:** Doubling the speed of a pump (same impeller) roughly **doubles the flow**, **quadruples the head**, and **octuples the power demand**. Likewise, using a pump with twice the impeller diameter (at the same speed) would boost flow about **8 times**, head **4 times**, and power about **32 times**. These strong scaling effects underscore why even modest changes can have big consequences. - **Usage:** Engineers use affinity laws to extrapolate performance: e.g. "How will this fan perform at 3,000 rpm if we know its performance at 1,500 rpm?" or "If we build a 3/4-scale model of a compressor, what will the full-size compressor do?" The laws provide quick answers without needing new experiments for every scenario.

Exam Handbook Search Cues (Not affiliated with or endorsed by NCEES): affinity laws; scaling laws; fans; pumps; compressors; performance scaling

Equation Passport – Affinity Laws (Similarity Scaling)

- **Name and purpose: Affinity Laws** – Predict how **flow rate (Q)**, **head (H)**, and **power ($\dot{W}$)** change for a turbomachine when you alter its rotational speed or impeller diameter. These laws allow scaling between two operating conditions (denoted "1" and "2") for geometrically similar machines handling the **same fluid**.

- **Governing equations (fully rendered):** For two similar conditions, the ratios of key performance variables are:

$$\frac{Q_2}{Q_1} = \frac{N_2}{N_1}\left(\frac{D_2}{D_1}\right)^3, \quad \frac{H_2}{H_1} = \left(\frac{N_2}{N_1}\right)^2\left(\frac{D_2}{D_1}\right)^2, \quad \frac{\dot{W}_2}{\dot{W}_1} = \left(\frac{N_2}{N_1}\right)^3\left(\frac{D_2}{D_1}\right)^5,$$

where condition 1 is a known reference point (existing machine or model) and condition 2 is the target point (new speed or size). These formulas give the **scaling factors** for volumetric flow Q, fluid head H (or equivalently pressure increase), and power $\dot{W}$. (If **mass flow** $\dot{m}$ is of interest, note $\dot{m} = \rho Q$; it scales like Q but with a density factor – see assumptions below.)

Variables and units:

- Q – Volumetric flow rate (e.g. $\mathrm{m^3/s}$ or $\mathrm{ft^3/s}$).

- H – Head (fluid static head or head gain, in units of length like m or ft). It's an energy-per-weight measure of pressure increase.

- $\dot{W}$ – Power imparted to the fluid (e.g. in watts, W, or horsepower, hp). Sometimes denoted P (power), but here P is avoided to not confuse with pressure.
- N – Rotational speed of the machine (e.g. in revolutions per minute, **rpm**, or rad/s).

- D – Impeller diameter or a characteristic length scale of the machine (e.g. in m or in).

- ρ – Fluid density (e.g. $\mathrm{kg/m^3}$ or $\mathrm{slug/ft^3}$). **Note:** ρ does **not** explicitly appear in the basic affinity ratios above for Q and H because those assume the same fluid. It will factor into pressure and power if fluids differ (see assumptions).

- Subscripts 1, 2 – Refer to the two conditions being compared (e.g. "1" = original or model, "2" = new or prototype).

Assumptions and scope:

- **Geometric similarity:** The machine's shape and flow path scales proportionally (angles, relative roughness, etc. are the same). Without geometric similarity, these exact exponents won't hold.

- **Same fluid (constant ρ):** The standard form assumes the fluid density is the same in both cases. If not, include density in pressure/head and power scaling. For example, the **pressure rise** scales as $\frac{\Delta P_2}{\Delta P_1} = \frac{\rho_2}{\rho_1}\left(\frac{N_2}{N_1}\right)^2\left(\frac{D_2}{D_1}\right)^2$. The power scaling similarly gains a density factor: $\frac{\dot{W}_2}{\dot{W}_1} = \frac{\rho_2}{\rho_1}\left(\frac{N_2}{N_1}\right)^3\left(\frac{D_2}{D_1}\right)^5$. For most exam problems, $\rho_2/\rho_1 = 1$ (same fluid).

- **Same gravitational environment:** When dealing with head H, we assume g is the same in both conditions (e.g., both on Earth's surface). Head is related to pressure by $\Delta P = \rho g H$, so if gravity or density change, pressure scaling needs adjustment.

- **Steady, incompressible flow:** These laws assume the flow regime is comparable (usually turbulent, incompressible flow in pumps/fans). They don't directly apply to compressible flows (e.g.,

high-speed compressors near Mach 1) without additional correction factors.

Negligible efficiency change: We assume the efficiency of the machine stays roughly constant between the two conditions. In reality, extreme scaling (especially if Reynolds number changes a lot) can change efficiency, but exam questions typically imply constant efficiency for scaling.

Limit tests (sanity checks):

- If the new condition has **zero speed** ($N_2 \to 0$), the laws predict $Q_2 \to 0$ and $H_2 \to 0$: no rotation means no flow or head generation – that makes sense. Power $\dot{W}_2$ would also go to zero (no work done on fluid).

- If the impeller size is **shrunken to zero** ($D_2 \to 0$), similarly $Q_2, H_2, \dot{W}_2 \to 0$ – a vanishingly small machine can't move fluid effectively.

- Conversely, if we vastly **increase speed or size** (say $N_2 \gg N_1$), the formulas yield very large $Q_2, H_2, \dot{W}_2$ – which is expected (a much faster/bigger machine can deliver much more flow, head, and requires much more power). Remember that real machines have limits, and huge increases might violate assumptions (e.g., cause cavitation or sonic flow), but mathematically the trend holds.

Use vs. sibling equations: Use these affinity law equations **instead of** complicated fluid dynamic equations when dealing with **similar pumps/fans at different speeds or scales**. They are your shortcut for scaling performance. **Do not confuse them with pipe flow formulas** (like Darcy-Weisbach) – affinity laws are for comparing two states of a turbomachine, not for calculating losses in a single pipe. Also, if a problem involves changing fluid or non-similar geometry, you can't use affinity laws blindly – look to general principles or other correlations in those cases.

Common exam traps:

- *Mixing up exponents:* A very common mistake is to apply the wrong power. For example, thinking flow scales with D^2 or head with D^3. Memorize the pattern: **Q** ~ N^1D^3, **H** ~ N^2D^2, **Power** ~ N^3D^5. A quick way to recall: flow gets the highest power on D (cubic, volume effect), head's total exponent sum equals 4 (square–square), and power's exponents sum to 8 (3+5). If you double check by units or simple scenarios (double speed, etc.), you can catch exponent errors.

- *Wrong ratio order:* Ensure you set up ratios correctly: if you're solving for Q_2, use $Q_2 = Q_1 \times (N_2/N_1)(D_2/D_1)^3$. Students sometimes invert the ratio (using N_1/N_2 by accident). A good habit is to phrase it: "I want condition 2, starting from condition 1." Thus if $N_2 > N_1$, Q_2 must end up larger than Q_1 – that's a clue your factor should be greater than 1, not less.

- *Unit confusion:* The formulas use **dimensionless ratios**, so you can plug in speeds in rpm or diameters in inches, as long as both numerator and denominator use the **same unit**. The ratio will be correct and units cancel. A trap is mixing units (say D_2 in inches and D_1 in feet); always convert so D_2/D_1 is unitless. Similarly, head H can be in any length unit as long as consistent.

- *Pressure vs head:* Remember H is not the same as pressure P. If a question asks for pressure increase scaling, it's essentially the same ratio as head (assuming same fluid), but if fluids differ you'd need the density factor. Misidentifying what "P" stands for in the context (power vs pressure) can also be a trap – pay attention to units or context (pressure in Pa vs power in watts). In our formulas above, we used $\dot{W}$ for power to avoid this confusion.

- *Outside similarity range:* In extreme scenarios (very large speed up or a very small model), real-world effects like Reynolds number changes or cavitation might creep in, invalidating the pure affinity predictions. The exam will usually hint if that's a concern. If not mentioned, assume you can apply the formulas directly.

Footnotes:

- *Units sanity:* Because these formulas are used as ratios, units are inherently handled by the ratio (e.g., $\frac{N_2}{N_1}$ has no unit as long as both N are in the same unit). Just be mindful to use consistent units for each pair. If you ever solve them not as pure ratios (not recommended), then you'd have to include conversion constants (but again, stick to ratio form to avoid that).

- *Interpreting head:* "Head" H is typically given in meters or feet of fluid. It's related to pressure difference by $\Delta P = \rho g H$. In scaling, if ρ and g are constant, the head ratio and pressure ratio are identical. So you might see affinity laws stated in terms of pressure rise ΔP instead of H; just remember to include ρ if fluids differ.

- *Efficiency note:* Affinity laws don't explicitly include efficiency (η). If the exam question gives pump/fan efficiency or asks about power input vs output, consider that $\dot{W}$ in the formulas is usually the fluid power (output to fluid). The shaft power required will be $\dot{W}_{\text{shaft}} = \dot{W}_{\text{fluid}}/\eta$. If efficiency stays same, it cancels out in ratios. If efficiency changes, affinity laws alone won't capture that. For the FE exam, unless they provide efficiency data at two points, assume constant efficiency.

- *When only one factor changes:* If only **speed** changes (same machine, $D_2 = D_1$), the laws simplify: $Q_2/Q_1 = N_2/N_1$; $H_2/H_1 = (N_2/N_1)^2$; $\dot{W}_2/\dot{W}_1 = (N_2/N_1)^3$. If only **size** changes (e.g. comparing a model to a scaled-up machine at the **same speed**, so $N_2 = N_1$), then $Q_2/Q_1 = (D_2/D_1)^3$; $H_2/H_1 = (D_2/D_1)^2$; $\dot{W}_2/\dot{W}_1 = (D_2/D_1)^5$. These special cases might be directly tested with simple numbers.

- *Real-world limits:* In actual engineering, pushing affinity laws too far can lead to inaccuracies. For instance, doubling speed might cause cavitation in a pump even if the law predicts performance nicely. The FE problems, however, will stay in a reasonable range or be idealized so you can trust the math. Just keep in mind the laws presuppose no new phenomena (like cavitation, flow separation, etc.) kick in.

Special Notes – Calculator: Calculations with affinity laws are usually straightforward. Use parentheses and the y^x (power) key carefully. For example, to compute $Q_2 = Q_1 \times (N_2/N_1) \times (D_2/D_1)^3$, it's wise to calculate the ratio (N_2/N_1) and $(D_2/D_1)^3$ separately (or use parentheses) to avoid order-of-operations mistakes. In a multi-step scale-up (e.g., changing both N and D), you can multiply the factors in one formula as above. Always double-check that your result makes physical sense (e.g., if $N_2 > N_1$, you should get $Q_2 > Q_1$!). If not, re-check your input or ratio inversion.

Explanation & Analysis: Affinity laws are essentially **shortcuts derived from dimensional analysis**. Let's break down how each relation comes about and how to use them confidently: - **Flow Q scaling:** Imagine how much volume of fluid a rotating impeller can push per unit time. If you spin it faster (higher N), you cycle

through that volume more times per second – so flow goes up linearly with N. If you enlarge the impeller (higher D), the volume of fluid swept per revolution grows with the volume of the impeller's flow region. For similar geometry, linear dimensions scaling by D means volume scales by D^3. So combined, $Q \sim N \times D^3$. In the equation $Q_2 = Q_1 \frac{N_2}{N_1}\left(\frac{D_2}{D_1}\right)^3$, each symbol plays a role: N_2/N_1 is the speed factor (dimensionless) and $(D_2/D_1)^3$ is the size factor (also dimensionless). Multiplying Q_1 by these gives Q_2. **Units:** Q might be given in m^3/s or $\mathrm{gallons/min}$; as long as you apply the ratio, Q_2 will emerge in the same unit as Q_1. If N is given in rpm, you use rpm ratio (the units cancel). There's no need to convert rpm to rad/s, for instance, since it's a ratio – but if you did, it would still cancel out.

- **Head H (or pressure) scaling:** The term "head" refers to the height of fluid column equivalent to the energy increase from pump/fan. Why does H scale as N^2D^2? It's essentially because the fluid's velocity gains scale with N and D. A rough reasoning: the tip speed of an impeller v_{tip} is proportional to $N \times D$ (more RPM or a larger diameter gives higher blade tip speed). The pressure rise (or head) created by a pump or fan is related to the kinetic energy imparted to the fluid, which goes like v^2. So if $v \sim ND$, then dynamic pressure $\sim (ND)^2 = N^2D^2$. Hence head $H \sim N^2D^2$ (with constant g and shape). In the equation, $\left(\frac{N_2}{N_1}\right)^2$ and $\left(\frac{D_2}{D_1}\right)^2$ are squared factors reflecting this quadratic relationship.

Units check: If H_1 was 5 m, and say $N_2/N_1 = 2$, $D_2/D_1 = 1$, then $H_2 = 5 \times 2^2 \times 1^2 = 20$ m. That's consistent: doubling speed quadrupled the head. If they asked pressure instead, you could convert that head to pressure via $P = \rho g H$. But notice, if ρ is same, pressure would be 4 times too. If ρ changed (perhaps testing with a fluid of different density), the head formula would stay N^2D^2 but actual pressure difference would include the density ratio.

- **Power $\dot{W}$ scaling:** Power is essentially (energy per unit mass) × (mass flow per time). In pump terms, $\dot{W} = \rho g Q H$ (for water pumps, ρg is weight density, so QH is volume * length = energy/time delivered). Ignoring constants, combine how Q and H scale: $Q \sim ND^3$, $H \sim N^2D^2$. Multiply them: $Q \times H \sim N^3D^5$. And there's a ρg in actual power, but if ρ and g are constant, the ratio for power comes out N^3D^5. The affinity law for power often surprises people with how steep it is – e.g., if you triple the speed ($N_2/N_1 = 3$) of a fan (keeping same D), the power requirement goes up by $3^3 = 27$ times (assuming it can actually draw that power)! Each symbol check: $\left(\frac{N_2}{N_1}\right)^3$ (cube of speed ratio) and $\left(\frac{D_2}{D_1}\right)^5$ (fifth power of size ratio) multiply $\dot{W}_1$ to give $\dot{W}_2$. If any of these ratios is >1, power skyrockets. If ratios <1 (e.g., slowing down or using a smaller machine), power drops dramatically.

Units: If $\dot{W}_1$ is in horsepower and you apply the ratio, $\dot{W}_2$ will also be in horsepower. The ratio itself is unitless.

- **Putting it into practice:** On the exam, a typical use-case might be: *"A pump delivers 500 GPM at 30 ft of head when running at 1800 rpm. Estimate the head it will produce at 2400 rpm (same pump, same fluid, assuming ideal scaling)."* You identify that $N_2/N_1 = 2400/1800 = 1.333$ .... Since only speed changed (D constant), head scales as square of speed ratio. So $H_2 = 30 \times (1.333)^2 \approx 30 \times 1.78 = 53.4$ ft (approx). Flow would scale linearly: $Q_2 = 500 \times 1.333 \approx 667$ GPM. And power would scale by cube of 1.333 (which is ~2.37), so if the original required, say, 20 hp, now it'd need ~47.5 hp. You likely only needed to compute the asked quantity (head), but understanding the others helps verify the trend. Always double-check that the direction of change makes sense: higher speed -> higher head, which we got.

- **Geometric scaling (size change):** If instead the problem said a **scale model** pump (half diameter) is tested at the same speed as the real pump, how will flow differ? Use $D_2/D_1 = 0.5$, $N_2/N_1 = 1$. Then $Q_2/Q_1 = (0.5)^3 = 0.125$. So the model only pumps 12.5% of the flow of the full size, at equal rpm. Head $H_2/H_1 = (0.5)^2 = 0.25$ – the model develops one-quarter the head. That makes sense: smaller machine, less head. Power scales by $0.5^5 = 0.03125$ (3.125%), so the model needs very little power relative to the prototype. In practice, you might run the model faster to compensate – which leads to combined scaling cases.

- **Combined scaling:** If both speed and size differ, just combine the factors as the formulas show. For example, if a prototype is twice the size of a model ($D_2/D_1 = 2.0$) but the prototype runs at half the rotational speed ($N_2/N_1 = 0.5$), the flow scaling would be $Q_2/Q_1 = 0.5 * 2^3 = 4$. So the prototype (bigger but slower) still pumps 4 times the flow of the model. Head scaling: $H_2/H_1 = (0.5)^2 * (2)^2 = 1$; interestingly, in that scenario, the head comes out the same – the loss of speed exactly cancels the gain of size for head. Power: $\dot{W}_2/\dot{W}_1 = (0.5)^3 * (2)^5 = 2$; power doubles. This kind of combined case could be a question where you have to carefully insert both ratios.

- **Physical intuition:** Always ask if the result feels reasonable. Affinity laws themselves are intuitive if you think: bigger or faster = more flow and pressure. The exact exponents might not be intuitive at first, but practice with simple doubles/halves scenarios. If you accidentally square when you should cube, the number will seem off. For instance, if you mistakenly thought flow scales with N^2 and doubled speed, you'd predict 4x flow – which is too high; it should be 2x. By sanity-checking ("double speed should roughly double flow"), you catch the error.

- **Wrap-up:** Affinity laws are powerful because they turn a single known test point (or design point) into a family of predictions. On exam day, they save you from re-deriving fluid dynamics equations. Just be careful with the algebra, use the ratios method, and keep track of what's changing and what's held constant. With these laws, you can answer scaling questions in seconds and with confidence.

K10.T09.S02 – Dimensionless Parameters and Similarity (Reynolds Number Scaling)

Principle Introduction: When scaling fluid machinery, it's not enough to have geometric similarity; you also need to account for dynamic effects through **dimensionless parameters**. For most pump and fan flows, the Reynolds number $Re$is the key dimensionless quantity, comparing inertial effects to viscous effects in the fluid. If a model and the full-scale prototype are tested at the same Re, their flow behavior is more likely to match; especially the laminar/turbulent regime and boundary-layer features. Key points include:

- **Reynolds number**: $Re = \frac{\rho V L}{\mu}$ (density × velocity × length / viscosity). It characterizes flow regime. High Re means inertia dominates (turbulent flow likely), low Re means viscous forces dominate (laminar flow). In turbomachinery, we usually operate at high Re (turbulent). A model that's too small or slow could have a much lower Re than the real machine, leading to disproportionately higher viscous losses and a different performance. Matching Re (or keeping it high enough in both) is crucial for similarity.

- **Dynamic similarity**: For complete similarity, **all relevant dimensionless numbers** should match between model and prototype. Besides Re, other numbers can matter: e.g. **Froude number** $Fr = V/\sqrt{gL}$ if gravity (free-surface or open channel effects) is important, **Mach number** $Ma = V/c$ (or related **Cauchy number**) if compressibility is important, **Weber number** if surface tension is involved, etc. In typical pump/fan problems on the FE exam, flows are incompressible and no free surface, so **Reynolds number is the star**. We usually assume others either don't apply or are implicitly matched.

- **Re scaling in models**: If a model is smaller, to keep Re the same as prototype it often must run at a higher speed or use a fluid with lower viscosity. For example, a half-scale pump (L down by 2×) might need to double the velocity to keep Re similar (since $Re \sim VL$ for fixed fluid). In practice, achieving exact Re equality can be challenging; the goal is to be in the **same flow regime** (both turbulent with similar turbulence characteristics). Fortunately, many turbomachines operate in fully turbulent ranges where small Re differences don't drastically change performance.

- **Exam focus**: The exam may test whether you understand why a direct scaling might fail if Re isn't accounted for. For instance, a question could hint that a model's flow was laminar while the real pump's is turbulent, asking which similarity condition was violated. Or it might directly ask to calculate Re for model vs prototype to check dynamic similarity. Typically, if they mention "dynamic similarity" or "model testing assumes similarity," they expect you to use the affinity laws confidently (implying Re is matched). If they mention viscosity or give enough info, they might expect a check or ratio of Re.

Exam Handbook Search Cues (Not affiliated with or endorsed by NCEES): Reynolds number; dynamic similarity; similitude; dimensionless parameters; model vs. prototype

Equation Passport – Reynolds Number (Flow Similarity)

- **Name and purpose: Reynolds Number (Re)** – A dimensionless quantity used to predict flow patterns and ensure similarity between model and prototype. It quantifies the relative importance of inertia vs. viscosity in a fluid flow. **Purpose:** In scaling laws, matching the Reynolds number between a model and a full-scale machine ensures that both experience similar turbulence and friction characteristics.

- **Definition (equation):**

$$Re = \frac{\rho V L}{\mu} = \frac{V L}{\nu},$$

where ρ is fluid density, V a characteristic velocity, L a characteristic length (such as pipe diameter or impeller diameter), μ dynamic viscosity, and $\nu = \mu/\rho$ the kinematic viscosity. Re is dimensionless (no units). For two systems to be dynamically similar (neglecting other forces), you set $Re_{\text{model}} = Re_{\text{prototype}}$.

- **Variables and units:**

- Re – Reynolds number (dimensionless).

- ρ – Fluid density (e.g. kg/m^3 in SI, or slug/ft^3 in US customary).

- V – Characteristic velocity of the flow (e.g. m/s or ft/s). In a pump or fan, this might be the tip speed of the impeller or average flow velocity through a pipe or channel.

- L – Characteristic length (e.g. m or ft). Commonly a diameter or chord length depending on the problem context (for turbomachines, impeller diameter is a logical choice as a length scale for scaling studies).

- μ – Dynamic viscosity of the fluid (e.g. $\text{Pa} \cdot \text{s}$ or $\text{N} \cdot \text{s/m}^2$ in SI, which is equivalent to $\text{kg/(m} \cdot \text{s)}$; in USCS could be given in $\text{lbm/(ft} \cdot \text{s)}$ or more typically slug units).

- ν – Kinematic viscosity of the fluid (e.g. $\text{m}^2\text{/s}$ or $\text{ft}^2\text{/s}$), sometimes provided directly. It's simply $\nu = \mu/\rho$. Using ν can simplify Re calculation: $Re = VL/\nu$.

- **Assumptions and scope:**

- **Steady fluid and continuum:** Reynolds number is meaningful for continuum fluid flow where V, L, etc., are representative of the flow. It's assumed the flow is not so exotic (e.g., not a rarefied gas, not a granular flow) – typical liquids and gases in engineering contexts apply.

- **Same fluid or adjusted conditions for similarity:** To match Re between model and prototype, you might adjust V or use a different fluid viscosity if needed. For exam purposes, assume they intend for you to either see that Re is matched or compute a needed speed ratio. Usually, problems keep the **fluid the same** (water model for water prototype, or air for air) and ask if Re matches or how far off it is. If the fluid differs, that's a clue to include ρ and μ differences in analysis.

- **High vs low Re effects:** The Reynolds number's significance is that flows with $Re <\sim 2300$ (for pipes) are laminar, and flows with very high Re (tens of thousands or more) are turbulent. In turbomachinery, Re is typically high enough that the flow is turbulent in both model and prototype if scaled properly. We assume we're aiming for both to be either laminar-laminar or (more likely) turbulent-turbulent. The affinity laws work best in the fully turbulent regime where performance coefficients are nearly constant with Re.

- **Neglecting other dimensionless factors:** We assume other effects (compressibility, gravity, surface tension) are either negligible or separately handled. Reynolds is the primary one for viscous scaling. If, say, compressibility was important (Mach ~ 0.8 in a compressor), then Mach number should also be matched or the model should correct for it, but that would be a different scenario.

- **Limit tests:**

- If $\mu \to 0$ (very low viscosity, like ideal fluid), $Re \to \infty$. That suggests inertia dominates completely – a situation of fully turbulent or even inviscid-like flow.
- If $V \to 0$ or $L \to 0$, then $Re \to 0$. That indicates creeping, laminar flow where viscous forces dominate (no turbulence). For example, a very slow-moving fluid or a micro-scale device has low Re.

- **Model vs prototype:** If a prototype is much larger ($L_{\text{proto}} \gg L_{\text{model}}$) but you run them at the same fluid and speed, you'd get $Re_{\text{proto}} \gg Re_{\text{model}}$. Limit case: a tiny model might have such a low Re that its flow is laminar, while the big prototype is turbulent. In the exam context, that means **bad** similarity – the limit test shows you can't just shrink something too much and keep the same behavior unless you compensate (like increasing velocity or using a less viscous fluid for the model to bump its Re up).

- **Use vs. sibling parameters:** Use **Reynolds number matching** when flows are viscous-dominated or you suspect friction and

turbulence matter. Compare this to **Froude number** matching which you'd use if gravity-driven phenomena (waves, free surfaces) are key – e.g., in ship models or open channel flow models, Fr is crucial (so that model waves mimic prototype waves). In pump/fan problems, gravity doesn't usually enter (no free surface in the pump itself), so Reynolds is more relevant. If a problem statement brings up "viscosity" or "Reynolds," they're focusing on this. If they mention something like "the model is half-scale and tested in oil instead of water," you'd definitely want to check Re or at least viscosity ratios. **Don't confuse Reynolds number with Roughness Reynolds numbers or other dimensionless forms** – here we mean the classic flow Reynolds number.

Common exam traps:

- *Calculating Re in inconsistent units:* Perhaps the most common error is plugging values into $Re = \rho VL/\mu$ with mixed units. For example, using ρ in $\mathrm{kg/m^3}$, V in $\mathrm{ft/s}$, L in m, and μ in cP (centipoise) all at once – this will yield a nonsense Re. Always convert everything to one system (SI is easiest: ρ in kg/m³, V in m/s, L in m, μ in Pa·s) before calculating. Or use the alternate form $Re = \frac{VL}{\nu}$ if you have kinematic viscosity in consistent units (e.g., m²/s).

- *Misidentifying L or V:* Reynolds number needs appropriate characteristic scales. In a pipe flow, L is typically pipe diameter and V is average velocity in the pipe. In a pump, a logical choice is impeller diameter for L and something like tip speed or discharge velocity for V. If you choose inconsistent definitions between model and prototype, you won't compare like with like. The exam will usually guide you – e.g., if they give you a flow rate and pipe diameter, you know to use pipe diameter and flow/area for velocity.

- *Assuming similarity without checking:* Some might assume "small model, same fluid, oh well it's fine." The exam could exploit that: e.g., a model pump test in glycerin vs a prototype in water. If one neglects Re, they'd apply affinity laws directly and get a wrong answer. The trap is not recognizing the need for a viscosity or Re correction. If you see a different fluid or a mention of viscosity, it's a flag: **check Reynolds number**.

- *Laminar vs turbulent formulas:* If you find the model's Re is in laminar range but the prototype's is turbulent, affinity laws won't accurately predict pressure/head because frictional losses scale differently. In laminar flow, head losses scale ~ velocity (linear), whereas in turbulent they scale ~ velocity² (roughly). So the trap is trying to use one regime's expectations in another. The exam could ask conceptually, "Why did the model test fail to predict prototype pressure?" with answer like "because the model's Reynolds number was too low, causing flow regime mismatch."

- *Relying only on Re when others matter:* Another subtle point: if a problem involves something like a pump inlet free surface (suction in a tank) or maybe an airplane fan, sometimes Froude or Mach might matter. If they tell you "assume incompressible and no free surface effects," they're basically telling you those other numbers can be ignored, and Re is the one to watch. If they don't mention them at all, it usually means they're not relevant.

Footnotes:

- *Critical Reynolds ranges:* Remember the classic threshold ~2300 for pipe flow laminar-turbulent transition. For flow around objects (like an airfoil or impeller blades), transitions may occur at different Re, but generally by 10^5 or 10^6 you're turbulent. Most full-scale pumps/fans operate at Re in the millions. Scale models might drop to lower but usually still try to be high. On the FE, if you compute a Re and see it's, say, 500, that indicates laminar – a red flag if the real thing was likely turbulent.

- *Kinematic vs dynamic viscosity:* Many tables give viscosity in centistokes or say "kinematic viscosity = 1 cSt" etc. Kinematic (ν) is easier: e.g., water at 20°C has ν ~ $1.0 \times 10^{-6}\mathrm{m^2/s}$. If you have that, and a length and velocity, computing Re is one step (just be mindful of units). If you only have dynamic (like μ = 0.001 Pa·s for water) and density (1000 kg/m³), you can compute ν = μ/ρ anyway. Either route is fine; consistency is key.

- *Matching Re strategy:* In real design, to get model Re high, one trick is to use a more viscous fluid in the model (counterintuitive, but for example, air in a small model vs water in prototype – air's viscosity relative to density is higher, so Re in air is lower; you might test a model in water to simulate something in oil, etc.). Another is to just run the model at a higher speed. Just be aware of what direction changes push Re. If you need to increase Re, you can increase V or L, or decrease viscosity (choose a thinner fluid, or raise its temperature to reduce μ). On exam problems, they likely won't dive that deep, but a conceptual question might ask, "How could you improve dynamic similarity if the model's Reynolds number is too low?" (Answer: increase model speed, use a less viscous fluid, or increase model size).

- *Other dimensionless parameters:* Aside from Re, some related parameters in turbomachinery include **Euler number** $Eu = \frac{\Delta P}{\rho V^2}$ (often used in pump head coefficients), **Power coefficient** $\chi = \frac{\dot{W}}{\rho V^3 L^2}$, etc. In fact, the affinity laws themselves can be recast as stating that certain non-dimensional coefficients (flow coefficient Q/ND^3, head coefficient gH/N^2D^2) are constant for similar conditions. The exam probably won't ask for those explicitly, but understanding that the dimensionless viewpoint is behind the affinity laws can deepen your intuition.

Special Notes – Applying Reynolds Similarity in Problems: If a question involves model vs prototype with different sizes, always check if they intend for Reynolds effects to be considered. Sometimes the question will simplify life by stating "assume the model test is conducted such that dynamic similarity is achieved" – which is code for "Re (and other relevant numbers) are matched, go ahead and use affinity laws directly." If they do **not** say that, and they provide viscosity or mention laminar/turbulent, then you might have to do a bit more: possibly compute the Reynolds numbers for each and see if there's a discrepancy or if you need to find a speed at which they match. For instance, "At what speed should a 1/2-scale model be run to have the same Re as the prototype at 1000 rpm?" – you'd set $Re_{model} = Re_{proto}$ and solve for the model's N. Using $Re = \rho(ND)D/\mu$ (since V for a pump ~ proportional to ND), the N needed would scale inversely with length: likely model N must be 2× prototype N if D is 1/2, to compensate. Be ready to set up such proportional equations. Modern FE problems may not require heavy calculation here, but understanding the proportional reasoning is key.

Explanation & Analysis: Dimensionless parameters like Reynolds number underpin why the affinity laws work or break. Let's break down the role of Reynolds number in scaling:

- **Physical meaning of Re:** It's $\frac{\text{inertia force}}{\text{viscous force}}$ in a flow. A high Re flow (e.g., water through a large pump at high speed) means viscous effects (like friction, boundary layer thickness) are relatively small

fraction of the energy balance; inertia (mass × acceleration of fluid) dominates, leading to turbulent eddies and well-mixed flow. A low Re (like syrup in a small pump slowly turning) would be smooth, laminar, and highly affected by viscosity (meaning more energy lost to friction relative to what inertia tries to do).

- **Why matching Re matters for similarity:** The performance of a pump or fan depends on things like frictional losses in passages and how the flow separates or not – these are viscosity-related. If the model's Re isn't similar, the fraction of energy lost to friction in the model could be much higher (or lower) than in the prototype, meaning the model might under-predict or over-predict head, etc. For example, in a small-scale model, the boundary layer (where viscosity matters) takes up proportionally more of the flow passage, choking the flow more than in the large prototype. So the model might indicate a pump is less efficient or produces less head than the real one would.

- **Using Re in exam problems:** Often, Reynolds number appears in more straightforward fluid flow questions (pipe flow, etc.), but in this topic, it would be about scaling. A conceptual question may ask: *"A 1/4-scale model of a pump is tested in the lab. Why is it important to run the model at a higher RPM than the prototype's RPM to predict prototype performance?"* The answer in essence: to raise the model's Reynolds number (which would otherwise be 1/4 of prototype's if run at same RPM) so that it approaches the prototype's Reynolds number, achieving dynamic similarity.

- **Term-by-term clarity:** Consider $Re = \frac{\rho V L}{\mu}$. If we keep the **same fluid** (ρ, μ constant) for model and prototype, then Re scales as VL. Now, V in a pump roughly scales with ND (as earlier reasoning for tip speed or characteristic velocity). And L might scale with D. So for model vs prototype: $\frac{Re_{\text{model}}}{Re_{\text{proto}}} \approx \frac{(N_{\text{model}} D_{\text{model}})(D_{\text{model}})}{(N_{\text{proto}} D_{\text{proto}})(D_{\text{proto}})} = \frac{N_{\text{model}} D_{\text{model}}^2}{N_{\text{proto}} D_{\text{proto}}^2}$. If the model is 1/4 scale ($D_{\text{model}} = D_{\text{proto}}/4$) and run at the **same speed** ($N_{\text{model}} = N_{\text{proto}}$), then $Re_{\text{model}}/Re_{\text{proto}} = (1 * (1/4)^2)/(1 * 1^2) = 1/16$. The model's Re is only 1/16 of prototype's – likely a huge difference (maybe prototype Re is 2×10^5, model is 1.25×10^4, possibly dropping it into or near transitional range). That's not good for similarity. To compensate, you could increase N_{model}. How much? Set $Re_{\text{model}} = Re_{\text{proto}}$. Using the ratio above, we need $N_{\text{model}} = N_{\text{proto}} \times \left(D_{\text{proto}}/D_{\text{model}}\right)^2$. With a 1/4 scale, that's $N_{\text{model}} = N_{\text{proto}} \times (4)^2 = 16 \times N_{\text{proto}}$. In other words, the model must run 16 times faster to have the same Re! This might not always be feasible (the model could break or cavitate at that speed). In practice, one might settle for a moderately higher Re and accept some differences, or change fluid. But this calculation illustrates how strongly Re is affected by scale.

- **Exam tip:** If a question gives you a model and prototype scenario with different scales and asks for an *accurate* prediction, expect either they assume similarity (so you use affinity laws directly) or they give data to adjust for Re. One classic twist: they might give you the model's efficiency or head and mention the model's Re, then ask what the prototype's something is, hinting that maybe prototype does better due to higher Re (less friction). However, detailed correction for Re is likely beyond FE scope; it's more likely conceptual or qualitative.

- **Re vs other parameters:** While Re is usually king, be aware:

Froude number matters if, say, the pump is pumping into an open tank and waves or free-surface vortex might form (rare in pump performance context, more common in spillway or open channel). **Mach number** could matter for a high-speed compressor (FE Mechanical usually doesn't go deep into compressible turbomachinery, but just recall: Mach similarity would mean matching Mach numbers to ensure compressibility effects are similar). The handbook's mention of multiple force ratios (as we saw with those five dimensionless equations) is thorough, but in most cases, the exam narrows to the dominant ones. So don't stress about Weber or Cauchy unless the question explicitly points to surface tension or compressibility.

- **Summary:** Dimensionless parameters ensure apples-to-apples comparison. If you see a question about model testing, always think: *Geometric similarity? Check. Reynolds similarity? Check if needed.* Once you mentally check those off (or address them), you can safely use the scaling laws. If something is off (like drastically different Re), be suspicious of straightforward scaling and look for a conceptual answer. In general, for FE Mechanical, you won't be asked to do heavy fluid dynamic derivations – but recognizing when a scaling law is valid versus when a similarity condition is violated can be the difference between picking the right answer or the distractor.

K10.T09.S03 – Model Testing and Prototype Performance Prediction

Principle Introduction: Model testing is a practical application of scaling laws where engineers build a smaller version of a machine (or use an existing similar machine's data) to predict how the full-size **prototype** will perform. The idea is to use the model's measured performance and scale it up (or down) using the affinity laws, provided that **similitude** conditions are met:

- **Geometric similarity:** The model is a scaled replica of the prototype in shape and proportions. Every length on the model is, say, 1/n-th of the corresponding length on the prototype. Without this, data won't scale cleanly.

- **Kinematic & dynamic similarity:** The flow patterns and force balance in the model replicate those in the prototype. This usually means running the model under conditions that match key dimensionless numbers (as discussed: Reynolds number primarily, possibly others as needed). If done right, the model's efficiency, flow coefficients, etc., match the prototype's. In practice, perfect dynamic similarity can be tough, but engineers aim for it or correct for known differences. On the FE exam, you'll typically assume it's achieved unless told otherwise.

- **Scaling procedure:** Given model test results (like "model pump at X rpm produced Y flow and Z head"), you apply the affinity laws to project those results to the prototype scale. You will use the ratio of diameters (scale factor) and possibly different speed to compute prototype flow, head, and power. Essentially, the model's data is your "condition 1" and the prototype is "condition 2" in the formulas from subtopic S01.

- **Exam context:** A common exam scenario is: *"A 1/3-scale model of a centrifugal pump was tested at certain conditions. Use the results to estimate the full-scale pump's performance."* You might be given model flow, head at a certain speed, and asked for prototype flow or head at some other speed. Or vice versa (prototype known, find what model test should show). These questions test your ability to consistently apply the ratios and think clearly about what changes and what stays same. They also might test your awareness of similarity requirements (e.g., "if the model used oil and prototype uses water, what extra factor is needed?" – hint: density or viscosity considerations).

Exam Handbook Search Cues (Not affiliated with or endorsed by NCEES): model pump testing; prototype performance; similitude; scale model; affinity (for reference of laws)

Definition Passport – Similitude & Model Testing

- **Definition (plain language): Similitude** is the theory and practice of making a small-scale model replicate the behavior of a full-scale system. A successful model test maintains **geometric similarity** (same shape scaled down) and **dynamic similarity** (same relevant dimensionless parameters, so forces scale in proportion). In simpler terms, the model "behaves" like the real thing, just smaller and possibly faster, so its performance data can be converted to full scale results.

- **Where it matters (exam impact):** This concept appears in questions where you're given data from a model (or from one operating point of a machine) and need to predict another scenario. You use similitude (via the affinity laws) to do the conversion. A typical FE problem might give you a model's flow and head and ask for the prototype's flow or required speed to achieve a certain head. Understanding similitude assures you apply the correct ratios and recognize if any additional factors (like density differences or efficiency changes) are implied.

- **Common pitfall:** Not recognizing when similitude assumptions break down. For instance, forgetting to include a density ratio if the fluids differ, or using the affinity laws blindly when the problem hinted that the model's flow was laminar (low Re) and the prototype's is turbulent – in that case, the direct scaled answer might be off. Another pitfall is confusing which way to scale (e.g., multiplying when you should divide or vice versa). Always set up clearly: scale factor $= \frac{\text{prototype}}{\text{model}}$. If scale factor > 1 (prototype bigger/faster), prototype should have **more** flow, etc., than model.

- **Micro-check:** *True or False:* "If a 1/2-scale model of a fan is tested under dynamically similar conditions, the model's results can be directly scaled by the ratio of sizes to predict the full-size fan's performance." **(Answer: True.)** Under dynamic similarity (including matched Reynolds number, etc.), the affinity laws allow direct scaling by size and speed ratios. If dynamic similarity is not achieved, the statement would be false because the results would need correction factors.

Footnotes:

- *Scaling direction:* Be careful about phrasing. If the problem says the model is 1/3 scale, clarify if that means $D_{\text{model}} = \frac{1}{3} D_{\text{prototype}}$. Usually yes. So $D_{\text{prototype}}/D_{\text{model}} = 3$. That factor (3) is what you'd plug in as D_2/D_1 (if you take prototype as "2" and model as "1"). It sounds trivial, but under exam time pressure, misinterpreting which diameter ratio to use can lead to answers off by a factor of 3^something. Write down something like "scale factor = 3 (proto/model)" to keep it straight.

- *Different speeds:* Model tests often involve running at a different speed than prototype's eventual speed. The question might say, "model tested at 1800 rpm to predict prototype at 3600 rpm." This means both a size scale and a speed scale are in play. You can combine them in one step or sequentially (both ways yield the same result if done correctly). Sequential approach: first scale model -> prototype at model's speed (just size factor), then adjust speed to prototype's speed (speed factor). Either way, be systematic.

- *Power scaling and units:* If asked for power, ensure you clarify if they want the answer in, say, horsepower or watts. The affinity ratio will give you the factor, but you might need to convert units if the question's context is different. For example, model might have a power measured in watts, and you scale it. If prototype answer expects horsepower, convert after scaling.

- *Efficiency and other losses:* Usually exam problems assume efficiency constant as mentioned. But if they give an efficiency for model and another for prototype, then when scaling power you should scale the fluid power with affinity laws and then compute shaft power with respective efficiencies. This is rare but keep the logic in mind: performance (Q, H) scales by laws; if efficiency changes, the required input power doesn't scale exactly by $N^3 D^5$ because some losses scale differently.

- *Cavitation number:* One thing not explicitly in outline but tangentially: sometimes model testing also requires checking cavitation via a dimensionless index called **Thoma's cavitation number** or $NPSH$ scaling. FE likely won't go there, but be aware that extremely large scale or speed changes can cause cavitation in prototype even if model didn't, if not scaled properly. If an exam question mentions Net Positive Suction Head (NPSH) required vs available, then cavitation is on the table, but that's more in pump design specifics.

Special Notes – Solving Model-to-Prototype Problems: When you get a model/prototype question, try this step-by-step **scaling move**: 1. **Identify "1" and "2":** Decide which condition is your reference (1) and which is target (2). A logical choice is model = 1, prototype = 2. Write down the given values under each column so you keep them straight (e.g., D_1, N_1, Q_1, H_1 known; D_2, N_2 known maybe, find Q_2, etc.).

2. **Write the relevant affinity formulas:** If the question asks for flow, write $Q_2 = Q_1(N_2/N_1)(D_2/D_1)^3$. If head, $H_2 = H_1(N_2/N_1)^2(D_2/D_1)^2$. If power or required horsepower, use the power relation (and include efficiency if needed). Writing the formula helps prevent mixing up factors.

3. **Plug in ratios:** Compute N_2/N_1 and D_2/D_1 separately. This not only helps avoid mistakes but also gives you an intuition (e.g., $N_2/N_1 = 2$ means we're doubling speed, $D_2/D_1 = 3$ means prototype is three times bigger). Then raise to proper exponents and multiply by the known value.

4. **Adjust units if needed:** Usually, the result will be in the same units as the known data, which should match question's asked units. If not, convert at the end.

5. **Check for similarity conditions:** If the problem text mentions anything about viscosity, Re, or "assume similarity" – incorporate that in your thinking. "Assume similarity" means go ahead as above. If there's a viscosity difference or a potential Re issue, you might need an extra step (like including a density ratio, or ensuring speeds are set such that Re match). If they don't mention it, don't overcomplicate – apply the laws and get the result.

6. **Sanity check the answer:** Does the prototype produce more flow if it's bigger/faster? It should. Is the head reasonable? For instance, if model head was 5 m, prototype shouldn't come out to 0.5 m if prototype is larger or faster – that would indicate a mis-inversion. Quick mental estimates (half size should yield ~1/8 flow at equal speed, etc.) can prevent leaving a wrong answer. On multiple choice, if two options are inverted (one 8x and one 1/8x), you'll catch which is sensible.

Let's run a **sample analysis**: *A 1/2 scale model of a pump is tested at 2000 RPM. It achieves 100 GPM flow and 40 ft head. Predict the*

flow and head for the full-size pump at 1200 RPM.
- Here, model = 1 (D1 half of D2, N1=2000), prototype = 2 (D2 is double D1, N2=1200). We list: $N_1 = 2000,\ Q_1 = 100,\ H_1 = 40;\ N_2 = 1200,\ D_2/D_1 = 2$. We want Q_2, H_2.
- Write formulas: $Q_2 = 100 \times \frac{1200}{2000} \times (2)^3$. $H_2 = 40 \times \left(\frac{1200}{2000}\right)^2 \times (2)^2$.

- Compute: $N_2/N_1 = 1200/2000 = 0.6$. $(D_2/D_1)^3 = 2^3 = 8$. So $Q_2 = 100 \times 0.6 \times 8 = 480$ GPM. For head: $(N_2/N_1)^2 = 0.36$, $(D_2/D_1)^2 = 4$. So $H_2 = 40 \times 0.36 \times 4 = 57.6$ ft.

- Check logic: The prototype is bigger but slower. Flow outcome 480 GPM vs model's 100 GPM – that's 4.8×, does that make sense? Size gave ×8, but slower speed gave ×0.6, net ×4.8, yes. Head outcome 57.6 ft vs 40 ft – head went up by factor 1.44. Size gave ×4, slower speed gave ×0.36, net ×1.44. So even at lower rpm, the big pump still produces more head than the small one at high rpm, because size matters a lot for head too. This seems plausible. If we had accidentally inverted something (like used 1/2 instead of 2 or 2000/1200 instead of 1200/2000), the numbers would be way off (e.g., head might have come out 11.25 ft, clearly wrong direction since a bigger pump should not drastically lose head when slowed moderately). So the answers 480 GPM and ~58 ft head are reasonable.

- Notice we didn't explicitly consider Reynolds number here. Implicitly, we assumed dynamic similarity. If the problem wanted to be pedantic, they could ask "should we be concerned about Reynolds difference?" Given the data, maybe not – but if model at 2000 rpm half-size vs prototype 1200 rpm full-size, their Re might actually not match perfectly. However, typically, the question wouldn't dive into that unless they gave viscosity info to play with. So we proceed with pure affinity laws unless prompted otherwise.

By following a structured approach and remembering the conditions under which scaling is valid, you can confidently tackle any question about fans, pumps, or compressors scaling on the FE Mechanical exam. Always keep one eye on the assumptions (same fluid? turbulent flow? geometric similarity?) and the other on the math of the affinity equations. Do that, and these problems become some of the quickest points you can score. Good luck, and happy scaling!

DON'T MOVE ON YET!

Work Through Some Solid Practice Problems
while the Material of this Knowledge Is Still Fresh
THIS IS HOW THE CONCEPTS LOCK IN.

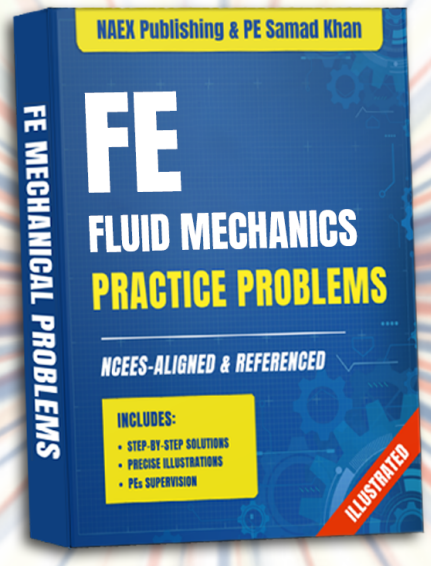

CLICK HERE TO PRACTICE

You'll be taken to our Discord Server, where the problems are located.

KNOWLEDGE 11

THERMODYNAMICS

- NAEX Publishing -

"This publication is not affiliated with or endorsed by NCEES".

Topic 01 - Properties of Ideal Gases and Pure Substances

Topic Introduction: This chapter covers the fundamental thermodynamic properties and relationships for ideal gases and pure substances. Mastering these basics is crucial for the **FE Mechanical Exam**, as they underlie many problems in thermodynamics, heat transfer, and fluid mechanics. You'll learn how to identify key **state variables** (pressure, temperature, volume, etc.), apply the **ideal gas law**, interpret **phase-change data** (quality, saturated conditions), use **thermodynamic property tables**, and handle **ideal gas mixtures**. On exam day, you can expect questions like: *"Given a gas at one state, find a missing property at another state using $PV = mRT$,"* or *"Determine the quality of steam and its enthalpy from a steam table,"* or *"Calculate the partial pressure of a gas in a mixture."* The goal here is to build a rock-solid intuition and a quick-reference "toolbox" for these topics, so you can confidently tackle such problems under exam conditions.

K11.T01.S01 – Thermodynamic State Variables and Units

Principle Introduction (Background Theory):

State Variables: Thermodynamic state variables (properties) describe the condition or **state** of a system at equilibrium. Important ones include **Pressure (P)**, **Temperature (T)**, **Volume (V)** (and **specific volume v**), **Internal Energy (U)** (and **specific internal energy u**), **Enthalpy (H)** (specific enthalpy h), and **Entropy (S)** (specific entropy s). Each has a precise physical meaning and units. They are **state functions**, so their change is determined only by the initial and final states, not by the particular path or process used to get from one to the other.

Intensive vs. Extensive: Properties may be **intensive** (independent of mass) or may be **extensive** (proportional to mass). Pressure and temperature are intensive (they don't scale with system size), whereas properties like volume, internal energy, enthalpy, and entropy are extensive. By dividing an extensive property by mass, we obtain a **specific property** (lowercase notation) which is intensive. For example, total internal energy U (extensive) vs. specific internal energy $u = U/m$ (intensive). Following this convention, extensive properties are often denoted with uppercase letters and their specific (per unit mass) counterparts with lowercase.

Units and Conventions: In SI units (the primary system on the FE exam), pressure P is measured in **Pascals (Pa)** (with 1 Pa = 1 N/m²). Often we use **kPa** or **MPa** for convenience. Temperature T is measured in **Kelvin (K)** – an absolute scale (0 K is absolute zero). Volume V is in **m³**, and specific volume v is in **m³/kg**. Internal energy U and enthalpy H are in **Joules (J)** (or often kJ), with u, h in **J/kg** (or kJ/kg). Entropy S uses **J/K** (or kJ/K), and s in **J/(kg·K)**. The US Customary Units (USCS) may also appear: e.g. pressure in **psi** (lbf/in²), temperature in **°R** (Rankine, the absolute Fahrenheit scale), volume in **ft³**, enthalpy in **Btu**, etc. Always pay attention to unit consistency – unit conversion errors are a common pitfall.

Absolute vs. Gauge: Pressure in thermodynamics must be an **absolute** pressure. Many gauges read zero at atmospheric pressure, but for calculations you need to add atmospheric pressure (≈101.3 kPa at sea level) to a gauge reading to get absolute. Temperature must also be absolute (use K or °R, not °C or °F in formulas). **Never plug a gauge pressure or a Celsius temperature directly into formulas like $PV = mRT$** – convert them first [^1].

Enthalpy and Derived Properties: Enthalpy H is a composite property defined by $H = U + PV$. It's effectively the total energy content of a fluid, combining internal energy and the energy needed to "make room" for the fluid (the PV term). Specific enthalpy $h = u + Pv$ has units of energy per mass (J/kg). Entropy S is a measure of disorder or energy dispersal per temperature (with specific entropy s in J/(kg·K)). We'll see how changes in these properties are used in energy equations. While **U, H, S** themselves are not directly measured on a routine basis, changes in them determine how systems absorb or release energy. For a given **single-phase pure substance**, if any **two independent intensive properties** are fixed (say P and T), all other properties (v, u, h, s) become fixed by the equations of state or property relations. This two-property rule is the backbone of using thermodynamic tables and diagrams.

Exam Handbook Search Cues (Not affiliated with or endorsed by NCEES): pressure; temperature; specific volume; internal energy; enthalpy; entropy; intensive vs extensive

Footnotes:

[^1]: *Always use absolute scales:* Convert °C to K by adding 273.15. Convert gauge pressure Pg to absolute by $P(abs) = P(gauge) + P(atm)$ (with $P_{atm} \approx 101.3$ kPa at sea level, or 14.7 psi). Using gauge values in formulas will produce wrong results.

Variations, Related Forms, Typical Values:

- **Intensive/Extensive Clues:** Mass-independent properties (intensive) include not just P and T, but also density (the inverse of specific volume) and specific heats (more on those later). Mass-dependent ones (extensive) include volume, energy, enthalpy, entropy, and also properties like mass itself (trivially) and total moles N in a system. The exam may ask conceptually which properties are intensive vs extensive, so remember: if you double the amount of substance and the property doubles, it's extensive; if it stays the same, it's intensive.

- **Units Check:** It's good practice to keep track of units in calculations. For instance, 1 Pa = 1 N/m² = 1 kg/(m·s²). Also note 1 J = 1 N·m. These relationships can help catch mistakes (e.g. if you accidentally use pressure in bar or atm, convert to Pa before using SI-based R values). Typical atmospheric pressure is 101,325 Pa, typical room temperature is 298 K (25 °C). Specific internal energy and enthalpy of liquids/solids are on the order of a few hundred kJ/kg, while for gases they can vary widely (for example, at 300 K, u of an ideal diatomic gas might be ~$3/2$RT ≈ 312 kJ/kmol which is ~11 kJ/kg for air).

Explanation & Analysis:

Thermodynamic state variables are the basic descriptors of a system's condition. **Pressure (P)** physically means force per unit area exerted by the substance on the walls of its container (or within itself). **Temperature (T)** reflects the average kinetic energy of molecules – it tells us how hot something is and dictates the direction of heat transfer (hot → cold). **Specific volume (v = V/m)** is the space occupied by unit mass (the inverse of density ρ); for

gases, v is large and for liquids, v is small (e.g. $v_{water,liq} \approx 0.001\ \mathrm{m^3/kg}$ at room temp, whereas $v_{steam} \approx 1\text{–}10\ \mathrm{m^3/kg}$ at boiling, and for air at STP $v \approx 0.8\ \mathrm{m^3/kg}$). **Internal energy (U)** represents the microscopic energy stored in a substance (molecular kinetic + potential energies). **Enthalpy (H = U + PV)** can be thought of as the energy content useful for flow processes – it's especially handy when analyzing open systems like turbines, compressors, nozzles, etc., where fluid enters and exits (the *PV* term accounts for flow work). **Entropy (S)** is more abstract – it measures dispersal of energy: when heat is added reversibly, entropy increases by $dS = \delta Q_{rev}/T$. In practical terms, entropy tracks irreversibility and is constant in ideal *reversible* processes (more on that in second-law topics). Each variable has standard symbols and units – make sure not to confuse similar symbols (e.g. capital *V* vs lowercase *v*, *P* for pressure vs *p* sometimes used for density in other contexts). On the exam, you'll use these properties in formulas (like $PV = mRT$) and look them up in tables/diagrams for substances like water or refrigerants. Being comfortable with the notation and units is the first step to solving thermo problems quickly and correctly.

K11.T01.S02 – Ideal Gas Law and Assumptions

Principle Introduction (Background Theory):

Equation of State for Ideal Gases: The ideal gas law is the fundamental equation of state for an ideal gas. In its common form: $PV = m\,R\,T$, where *P* is the absolute pressure, *V* is the volume occupied by mass *m* of gas, *T* is absolute temperature, and *R* is the **specific gas constant** for that gas. An equivalent form is $P\,v = R\,T$, where *v = V/m* is specific volume. This law relates pressure, volume, and temperature under the assumption of ideal behavior. It can also be expressed as for a given mass of gas going from an initial state 1 to a new state 2. This is sometimes called the combined gas law, handy for solving problems where you have two states and assume the amount of gas is fixed and behaves ideally.

Gas Constant R: The constant *R* in the ideal gas equation is specific to each gas. It is related to the **universal gas constant** R_u by $R = \frac{R_u}{M}$, where *M* is the molar mass (molecular weight) of the gas. In SI units, $R_u = 8.314\mathrm{J/(mol \cdot K)}$. For example, air (approx 78% N_2, 21% O_2) has $M \approx 28.97\ \mathrm{kg/kmol}$, so $R_{air} = 8.314/28.97 \approx 0.287\mathrm{kJ/(kg \cdot K)}$ (which is $287\mathrm{J/(kg \cdot K)}$). Be careful: *R* has different values in different unit systems (e.g. $R_{air} \approx 53.3\mathrm{ft \cdot lbf/(lbm \cdot °R)}$ in US units), and the pressure and volume units must correspond. The exam reference handbook provides *R* for various gases and the value of R_u in convenient units.

Ideal Gas Assumptions: An *ideal gas* is a theoretical gas that perfectly follows the ideal gas law. The model assumes:

- Gas molecules are assumed not to interact with one another; there are no intermolecular attractive or repulsive forces.
- Gas molecules themselves occupy **negligible volume** (the molecules are point masses with no size).
- Molecular collisions, with each other and with the container walls, are assumed to be random and perfectly elastic (as in the kinetic-theory basis of the law). Under these assumptions, the internal energy depends only on temperature (not on pressure or volume directly), and the gas obeys $PV \propto T$ exactly. Real gases deviate from this behavior at **high pressures** or **low temperatures** (near liquefaction), where intermolecular forces and molecular size become significant. As a rule of thumb, most gases at pressures below about **3 atm** and not too close to their condensation point behave approximately ideally. The FE exam will usually specify if non-ideal behavior must be considered (e.g. using a compressibility factor Z or other equations of state), but typically, unless conditions are extreme or data is provided, you can assume ideal gas behavior for common gases.

Limitations and Domain: The ideal gas law breaks down near the gas's **critical point** or at very high pressure. For instance, water vapor at 1 atm and 150°C behaves fairly ideally, but at 50 atm and 150°C it does not (it's much closer to being a compressed liquid). If you suspect non-ideal conditions, the exam might supply a **compressibility factor** Z or indicate use of a different equation of state (like Van der Waals or similar) – but this is rare in FE Mechanical. Generally, if it looks like a straightforward gas problem, use $PV = mRT$. When in doubt, check if given data fits an ideal pattern (e.g. a provided specific volume vs what mRT/P yields).

Equation Passport: Ideal Gas Law

- **Name and Purpose: Ideal Gas Law** – relates pressure, volume, temperature, and mass for an ideal gas; used to compute one property when the others are known, or to convert between specific volume and density, etc. It's the go-to equation of state for gases in many FE problems (e.g. finding a missing T, P, or v).

- **Formulation (Professional Equation):** equivalently $P\,v = R\,T$, or (for a fixed mass).

Variables and Units:

- *P* = absolute pressure of the gas (SI: Pa; USCS: psi or lbf/ft²)
- *V* = volume occupied by the gas (SI: m³; USCS: ft³)
- m = mass of the gas (SI: kg; USCS: lbm)
- $v = V/m$ = specific volume (SI: m³/kg; USCS: ft³/lbm)
- *T* = absolute temperature (SI: K; USCS: °R)
- *R* = gas constant for the specific gas (SI: J/(kg·K) or kJ/(kg·K); USCS: ft·lbf/(lbm·°R)).

For example, $R_{\mathrm{air}} \approx 287\mathrm{J/(kg \cdot K)}$ in SI units. Note that $R = R_u/M$ where $R_u = 8.314\mathrm{J/(mol \cdot K)}$ is universal and M is the molar mass.

Assumptions and Scope:

- Gas must be in a thermodynamic equilibrium state (uniform P, T, etc.).
- Behaves ideally (low density, far from liquefaction). No significant intermolecular forces or molecular size effects.
- Valid for both static states and processes (with m constant).
- Not applicable for liquids/solids (which are incompressible in comparison) or gases in highly non-ideal conditions (use other models in those cases).

Limit Tests (Sanity Checks):

- As $T \rightarrow 0$ (at constant m, V), the pressure $P \rightarrow 0$ – indeed at extremely low temperatures, gas pressure approaches zero (makes sense, molecules hardly move).
- As $V \rightarrow \infty$ (with fixed m, T), $P \rightarrow 0$ – infinite volume means extremely low density, pressure should approach zero (ideal gas makes sense as molecules barely hit container).
- If you accidentally use gauge pressure (e.g. $P_{gauge} = 0$ at atmospheric conditions), the formula would erroneously give $T = 0$ – a clear sign something's off. So if you ever get an absurd result (like negative or zero temperature), check that you used absolute pressure and temperature.

- **Use vs. Sibling Equations:** Use the ideal gas law instead of steam tables or compressibility charts **when the substance is a gas at conditions well away from condensation** (e.g. air at room conditions, helium in a balloon, etc.). If the problem involves **vapor-liquid mixtures or saturated steam**, use steam tables (not $PV = mRT$). If given a **compressibility factor** Z, you might use the modified form $PV = Z\, m\, R\, T$ for a real gas, but that's essentially an adjustment to the ideal gas law when slight non-ideal behavior is considered.

Common Exam Traps:

- **Units mix-up:** Using $R = 287\text{J}/(\text{kg} \cdot \text{K})$ with P in kPa and V in m³ will fail unless you convert kPa to Pa (since $287\text{J}/(\text{kg} \cdot \text{K})$ assumes P in Pa). Always match units: e.g. if P is in kPa, either convert it to Pa or use $R = 0.287\text{kJ}/(\text{kg} \cdot \text{K})$ (note the kJ).
- **Gauge vs Absolute:** As noted, forgetting to convert gauge pressure or Celsius temperature to absolute can zero out or wildly skew your results. The exam may give, for instance, "a tank at 200 kPa (gage) and 25°C" – you must convert that to $P = 300$ kPa abs (assuming 100 kPa ambient) and $T = 298$ K before applying the ideal gas law.
- **Mixing up R values:** Don't confuse the gas constant R for a specific gas with the universal gas constant R_u. Also, within the same problem ensure consistency: if using per-mole basis (n moles), use $PV = n\, R_u\, T$ (with $R_u = 8.314$ J/mol·K), but if using per-mass basis (m in kg), use $PV = m\, R\, T$. The exam usually sticks to the mass basis for engineering problems, but double-check what data you're given (sometimes they might give moles, N, explicitly – in which case use R_u).

Exam Handbook Search Cues (Not affiliated with or endorsed by NCEES): ideal gas; $PV = mRT$; gas constant R; equation of state; ideal gas assumptions

Special Notes (Calculator Tips): Entering the ideal gas law in your calculator is straightforward. Just remember to group terms to avoid algebra mistakes: e.g., if solving for T, compute $T = \frac{P \times V}{m \times R}$. On a Casio or TI, that might be typed as (P*V)/(m*R). It sounds trivial, but under pressure (no pun intended) it's easy to make parentheses slip, so write it out clearly.

Explanation & Analysis:

The ideal gas law is essentially a simplified model for gases that lets you interconvert P, V, T, and mass. It comes from experimental observations (like Boyle's Law, Charles' Law) combined with the kinetic theory of gases. For example, if you heat a fixed mass of gas (increase T) at constant volume V, the pressure P will rise (imagine a sealed rigid container – heating it makes the molecules move faster, hitting walls harder, raising P). Quantitatively, $P = mR\,T\,/\,V$, so P is directly proportional to T (in Kelvin) if V and m are constant. Likewise, at constant T, PV is constant (Boyle's law) – compressing the gas (lower V) raises P. The constant of proportionality R encapsulates how easily a particular gas's pressure changes with T and V; lighter molecules (low molar mass) have larger R per kg (since one kg has more moles).

Each symbol in $PV = mRT$ has a physical role: - P pushes the container walls (or whatever confines the gas). - V is how much space the gas fills. - T measures kinetic energy of molecules. - m is how many molecules (in mass) you have, and - R adjusts for the gas's nature (essentially $R = R_u/M$).

A common use in FE problems: determine the missing property of a gas after some process. For instance, "Air in a piston-cylinder is compressed from 1.2 m³ to 0.3 m³ at a constant temperature of 300 K. If initial pressure was 100 kPa, what is final pressure?" Using $P_1\, V_1\,/\,T_1 = P_2\, V_2\,/\,T_2$ (with $T_1 = T_2$), you'd get $P_2 = P_1\, \frac{V_1}{V_2} = 100 \times \frac{1.2}{0.3} = 400$ kPa. This straightforward application is very typical. Another scenario: converting between density and specific volume, since $\rho = 1/v = \frac{m}{V}$, the ideal gas law can be written $P = \rho\, R\, T$. If a problem gives you gas density and temperature, you can find pressure easily with that form.

In analysis, always double-check the regime: if, say, they give you steam at 120°C in a closed vessel at some pressure, check if 120°C is the saturation temperature at that pressure or superheated – if it's saturated water vapor, you shouldn't use $PV = mRT$ blindly (steam might not behave ideally at higher pressures or could be a mixture). But if it's clearly a low-density gas (like helium, air, nitrogen at moderate P, T), ideal gas law is your friend. It's one of the most widely applied equations in thermodynamics for the FE exam, so practice recognizing when to use it and ensure your units are consistent when you do.

K11.T01.S03 – Specific Heats for Ideal Gases (c_p, c_v) and Mayer's Relation

Principle Introduction (Background Theory):

Specific Heats (Heat Capacities): Specific heat is the amount of energy required to raise the temperature of a unit mass of a substance by one degree, under stated conditions. For gases, we distinguish two important specific heats:

- c_p**:** specific heat at constant pressure – the energy per unit mass needed to raise the temperature by 1 K while keeping pressure constant (allowing the gas to expand). It is related to changes in **enthalpy**: $c_p = (\frac{\partial h}{\partial T})_P$.
- c_v**:** specific heat at constant volume – the energy per unit mass to raise the temperature by 1 K while keeping volume constant (no work done by expansion). It relates to **internal energy**: $c_v = (\frac{\partial u}{\partial T})_V$.

Both c_p and c_v have units of energy per mass per degree (e.g. kJ/(kg·K) or Btu/(lbm·°R)). These properties can be functions of temperature for real gases, but within moderate temperature ranges or in exam problems, they are often treated as constants given for a particular gas (like c_p of air ≈ 1.005 kJ/(kg·K) at room temp, c_v ≈ 0.718 kJ/(kg·K) for air).

Mayer's Relation (Ideal Gases): For an ideal gas, these two specific heats are related by a simple formula: $c_p - c_v = R$. This is known as Mayer's relation. It arises because at constant pressure, when you add heat, part of the energy goes into raising the temperature (increasing internal energy) and part is used for work of expansion ($P\,\Delta\,v$). The difference $c_p - c_v$ exactly accounts for that $P\,dv$ work per unit mass per degree, which for an ideal gas turns out to equal the gas constant R. Intuitively, c_p is always larger than c_v because heating at constant pressure lets the gas expand and do work, requiring extra energy input for the same temperature rise.

Specific Heat Ratio (γ or k): The ratio (often denoted by γ in thermodynamics textbooks) is a useful parameter for ideal gases. It typically ranges from about 1.3 to 1.67 for common gases. For example, for diatomic gases like air (mostly N_2 and O_2), $k \approx 1.4$ at room conditions. For monatomic gases like helium, $k \approx 1.67$. This ratio appears in formulas for isentropic (constant entropy) processes, sound speed in gases, etc. (e.g., isentropic relation $P\,v^k = \text{constant}$ for an ideal gas, which is used in some expansion/compression process calculations). While k itself might not be directly asked in an FE question, you might be given k to indicate an ideal gas's properties or to use in an isentropic process equation. Remember, $k > 1$ always, since $c_p > c_v$.

Temperature Dependence: For an ideal gas, c_v and c_p can vary with temperature (especially over large ranges). However, over small temperature intervals or for simplicity, we often assume they are constant. The FE Exam's reference (and typical problems) either give you a constant value or the problem will provide values or ask for ratio usage. If needed, it's safe to assume an average constant value unless told otherwise ("cold air standard" assumption means using room-temperature specific heats as constants). Under that assumption, changes in internal energy and enthalpy can be computed by $\Delta\,u = c_v\,\Delta\,T$ and $\Delta\,h = c_p\,\Delta\,T$ respectively.

Equation Passport: Mayer's Relation for Ideal Gases

Name and Purpose: Mayer's Relation gives the difference between an ideal gas's specific heats at constant pressure and at constant volume. It's used to find one specific heat if the other is known, or to check consistency of given data. It also reinforces that an ideal gas needs extra energy at constant pressure to account for expansion work.

Formulation: $c_p - c_v = R$

Variables and Units:

- c_p = specific heat at constant pressure (units: J/(kg·K) or kJ/(kg·K); in USCS, Btu/(lbm·°R))
- c_v = specific heat at constant volume (same units as c_p)
- R = specific gas constant (J/(kg·K) or equivalent) – **note:** here R must be in the same energy per mass per degree units as the c_p and c_v you're using. For example, if c_p and c_v are in kJ/(kg·K), use R in kJ/(kg·K) (for air, $R = 0.287$ kJ/(kg·K) when $c_p = 1.005$ kJ/(kg·K), $c_v = 0.718$ kJ/(kg·K), and indeed $1.005 - 0.718 = 0.287$).

Assumptions and Scope:

- Gas behaves ideally (Mayer's relation is exact for ideal gases, but not for non-ideal gases or liquids/solids).
- c_p and c_v are for the same gas and defined per unit mass.
- Usually assumes a constant composition gas (for mixtures, a similar relation holds with mixture-averaged c_p and c_v if you use mixture R).
- Not applicable if phase change occurs during heating (since c_p, c_v are defined for single-phase heating processes).

Limit Tests:

- If you plug in a monatomic ideal gas's degrees of freedom result: for a monatomic ideal gas (like argon), kinetic theory gives $c_v = \frac{3}{2}R$ and $c_p = \frac{5}{2}R$, so $c_p - c_v = R$ checks out (e.g. $2.5R - 1.5R = 1R$). For a diatomic, $c_v \approx \frac{5}{2}R$, $c_p \approx \frac{7}{2}R$ (at moderate temps, neglecting vibration), again difference is R.
- If hypothetically $c_p = c_v$ (no difference between heating at constant P vs V), the relation would imply $R = 0$. That would correspond to an infinite molecular weight gas or a situation where no expansion work is needed (not physical for a gas). So if you ever see data where c_p and c_v are nearly equal, double-check units or whether it's actually a liquid/solid (where indeed $c_p \approx c_v$ because expansion is negligible in solids/liquids).
- **Use vs. Sibling Equations:** Use $c_p - c_v = R$ when you have one specific heat and need the other quickly (e.g., a problem gives c_p of a gas and asks for c_v or vice versa). If you need to compute changes in energy: use $\Delta\,u = c_v\,\Delta\,T$ or $\Delta\,h = c_p\,\Delta\,T$ for ideal gases (those come from integrating the definitions assuming constant specific heats). In contrast, if dealing with liquids/solids, remember there's essentially one relevant c (no distinction between c_p and c_v in incompressible substances, they're approximately equal and expansion work is negligible).

Common Exam Traps:

- **Mixing units or basis:** Ensure R is on a per-mass basis to match c_p, c_v. If c_p, c_v are given per mole, then use R_u (per mole) for the relation. For example, if an exam problem gave C_p and C_v in J/mol·K, then you'd use $R_u = 8.314$ J/mol·K and check $C_p - C_v = 8.314$ J/mol·K.
- **Confusing R and R_u in this context:** A common mistake is to plug R_u (8.314) directly for R without accounting for molar mass. Always clarify whether you're working per kg or per kmol.
- **Assuming constant values outside valid range:** If a problem covers a large temperature change (say heating air from 300 K to 1200 K), strictly speaking c_p increases with T. Using a single average c_p might introduce small error. The FE exam typically avoids high-precision pitfalls like that unless it explicitly provides data or asks conceptually. When in doubt, use given values or the reference handbook values at an average temperature.

Exam Handbook Search Cues (Not affiliated with or endorsed by NCEES): specific heat; c_p; c_v; heat capacity; $c_p - c_v = R$; specific heat ratio k (or γ)

Variations and Typical Values:

- For common gases: **Air** (diatomic mixture) has $c_v \approx 0.718\text{kJ/(kg} \cdot \text{K)}$, $c_p \approx 1.005\text{kJ/(kg} \cdot \text{K)}$ at 300 K, and thus $c_p - c_v \approx 0.287$ kJ/(kg·K) which equals R_{air}. **Steam** (water vapor treated as ideal gas at low pressure) has $c_p \approx 1.872$ kJ/(kg·K), $c_v \approx 1.410$ kJ/(kg·K) at 300 K (so difference ≈0.462 kJ/kg·K, matching R_{H2O}). The exam may provide these or ask you to recall/order magnitudes. **Monatomic gases** (like helium, argon): c_p is about 5/2 R, c_v 3/2 R; e.g. for Helium, $R_{He} = 2.077$ kJ/(kg·K), so $c_v \approx 3.12$ kJ/(kg·K), $c_p \approx 5.20$ kJ/(kg·K), and indeed difference ~2.08 kJ/(kg·K).

- **Incompressible substances (liquids/solids):** They effectively have one specific heat value (no distinction between c_p and c_v because volume change is negligible when heating at constant pressure). For example, water as a liquid has $c \approx 4.18$ kJ/(kg·K) (which is why it takes 4.18 kJ to heat 1 kg of water by 1°C). But for gases, c_p is the one used when a gas expands (common in open-flow processes), and c_v is used for fixed volumes (like in a rigid tank heating).

Explanation & Analysis:

Understanding c_v and c_p is important for energy calculations. If you add heat Q to a gas in a rigid container (no work done), all that energy goes into raising the internal energy: $Q = \Delta U = m\, c_v\, \Delta T$. If you add the same heat to a gas in a piston-cylinder that maintains constant pressure, the gas will expand and do boundary work $W = P\, \Delta V$ while heating. In that case, you need a bit more heat to achieve the same temperature change: $Q = \Delta H = m\, c_p\, \Delta T$ (and indeed $\Delta H = \Delta U + \Delta(PV) = mc_v\Delta T + mR\Delta T$, which yields $m\, c_p\, \Delta T$ since $c_p = c_v + R$). In plainer terms, c_p **includes the energy to push back the atmosphere (or whatever is maintaining pressure)**, whereas c_v is just the internal energy change.

For ideal gases, because internal energy u is function of T only, $du = c_v\, dT$, and enthalpy h is also function of T only, $dh = c_p\, dT$. These lead to the very useful relations: - $\Delta u = c_v(T_2 - T_1)$ - $\Delta h = c_p(T_2 - T_1)$

on the assumption c_v, c_p are constant over that range. The FE exam often leverages these in first-law energy balance problems. For example, in a closed system (no flow) problem: "A gas in a rigid tank is heated from 20°C to 100°C, find the change in internal energy," you'd use $\Delta U = m\, c_v\, \Delta T$. In an open system or steady-flow process: "Air enters a heating duct at 15°C and leaves at 55°C at roughly constant pressure, determine the added heat per kg air," you'd use $\Delta H = c_p\, \Delta T$ per kg (which is the heat added in a constant-pressure process per kg if kinetic/potential changes are negligible). If numerical values aren't given, you might use the standard values from the handbook.

Keep in mind the magnitudes: c_p is a bit bigger than c_v for gases – specifically by about 40% for diatomic gases (because $k \approx 1.4$), or by 67% for monatomic ($k \approx 1.67$). If you ever accidentally subtract wrong ($c_v - c_p$), you might get a negative "R" which is nonsense. So a micro-check: ensure c_p is the larger number. Also, be cautious if a problem involves mixed units (like giving you c_p in one set and R in another) – convert them consistently.

In summary, c_v and c_p link temperature changes to energy changes, and Mayer's relation binds them together for ideal gases. This relation is also a stepping stone to understanding thermodynamic processes (e.g., in isentropic processes of ideal gases, formulas involve $k = c_p/c_v$). As long as you remember $c_p > c_v$ and their difference equals R, you have a quick way to navigate many thermodynamics questions.

K11.T01.S04 – Phase Change in Pure Substances (Saturation and Quality)

Principle Introduction (Background Theory):

Phases of a Pure Substance: A pure substance can exist in solid, liquid, and gas (vapor) phases, and under certain conditions, multiple phases can coexist in equilibrium. Here we focus on the liquid–vapor phase change (relevant to water/steam, refrigerants, etc., as commonly encountered in thermo problems). **Saturation** refers to conditions where a phase change is about to occur. At a specified pressure, the saturation temperature T_{sat} is the boiling temperature where liquid and vapor can coexist; at a specified temperature, the saturation pressure P_{sat} is the vapor pressure, i.e., the pressure at which the substance boils at that temperature. At saturation, liquid and vapor phases can coexist in equilibrium.

Saturated Liquid and Vapor: A **saturated liquid** is a liquid at the brink of vaporizing (it holds as much internal energy as it can without boiling). A **saturated vapor** is a vapor at the brink of condensing (it's as dense as it can be without starting to liquefy). For example, water at 100°C and 101.3 kPa is saturated: it can exist as liquid water at 100°C or steam at 100°C, or a mixture of both. If you heat saturated liquid even a tiny bit (at constant pressure), it will start turning to vapor; if you cool saturated vapor a tiny bit, it will start condensing to liquid.

Two-Phase Mixture and Quality (x): When a substance is at saturation conditions but has partly liquid and partly vapor present, we have a **two-phase mixture** (often called a "wet vapor" if mostly vapor with some droplets, or "saturated mixture"). The **quality** x is defined as the fraction of the mixture's mass that is in the **vapor phase**.

- By definition, , where m_g is the mass of vapor (gas) and m_f is the mass of liquid ("fluid"). Quality is a number between 0 and 1 (or 0–100%).
- If $x = 0$ (0% quality), the substance is all liquid (saturated liquid state). If $x = 1$ (100% quality), it is all vapor (dry saturated vapor).
- For $0 < x < 1$, you have a mixture: e.g., $x = 0.25$ means 25% of the mass is vapor, 75% is liquid. You can think of quality as how "dry" or vapor-rich the mixture is – higher quality means more vapor (hence "quality").

- **Mixture Property Calculations:** In a two-phase mixture, many properties can be obtained by a **weighted average** of the saturated liquid and saturated vapor values, weighted by quality. Since intensive properties like specific volume, specific internal energy, specific enthalpy, and specific entropy are all expressed per unit mass, we can write linear interpolations:

- , where v_f is specific volume of saturated liquid and v_g is specific volume of saturated vapor at that pressure/temperature. Sometimes this is also written as $v = v_f + x\, v_{fg}$, where $v_{fg} = v_g - v_f$ is the difference (the increase in volume when 1 kg of liquid becomes vapor).

- Similarly, , , , where u_f, h_f, s_f are saturated liquid values and u_g, h_g, s_g (or sometimes denoted u_g as u_{vap} etc.) are saturated vapor values. And $h_{fg} = h_g - h_f$ is the latent heat of vaporization (the enthalpy change to go from liquid to vapor at that saturation condition). These relationships assume thermal equilibrium between the phases (common T and P).

In essence, to find, say, the enthalpy of a mixture with quality x, you interpolate between the enthalpy of saturated liquid h_f (at $x = 0$) and saturated vapor h_g (at $x = 1$) by the fraction x: $h = h_f + x(h_g - h_f)$.

Fixed Pressure or Temperature During Phase Change: A key point about saturation phase change is that, in the two-phase region, **temperature and pressure are linked and cannot be chosen independently**. If you're at a given pressure P_{sat}, the temperature will be T_{sat} for that pressure (and vice versa). As long as liquid and vapor coexist, any heat added or removed goes into changing the mixture's quality (evaporating or condensing more liquid) **without changing the temperature or pressure** (assuming it's a constant-pressure process like boiling in an open vessel, or constant-temperature process like condensing steam in a thermostatic bath at constant temperature). This is why on a P–v diagram, a constant-temperature line is flat during the phase change (pressure stays constant while volume changes), and on a T–v diagram, a constant-pressure line is flat (temperature stays constant while volume changes). It's also why water will stay at 100°C until all liquid turns to vapor (if heated at 1 atm) – the energy goes into phase change, not raising temperature.

Definition/Note Passport: Vapor Quality (x)

- **Plain-language Definition:** *Quality* (x) is the fraction of a saturated liquid–vapor mixture that is vapor, on a mass basis. For example, $x = 0.2$ (20% quality) means 20% of the mass is vapor and the remaining 80% is liquid. It's a way to specify how far along a boiling or condensing process the mixture is (0% = all liquid, 100% = all vapor).

- **Where it Matters (Exam Impact):** Quality comes into play whenever you deal with saturated steam or refrigerant mixtures. The FE exam may give you a pressure and a quality, and ask for a property like enthalpy or specific volume using steam tables. Or conversely, given a specific internal energy and pressure, determine the quality (how much vapor is present). It's essential for solving energy balance problems involving boilers, condensers, or any two-phase systems.

- **Pitfall or Confusion Point:** One common misunderstanding is to apply quality outside the two-phase region. Quality is **only defined for saturated mixtures**. If someone says "quality" for a state that is superheated vapor or subcooled liquid, it's meaningless (you might calculate an "x" > 1 or < 0 in those cases, which signals the state is not under the dome). Also, quality is not the same as vapor *volume* fraction (unless densities are similar, which they're not – vapor takes up most of the volume). It's a mass fraction: a small mass of vapor can occupy a huge volume. So don't confuse 10% quality with "10% of volume is vapor" – in fact, at 10% quality, typically well over 90% of the volume is vapor, since vapor is much less dense than liquid.

- **Micro-check:** True or False? *"At 50% quality, the temperature of the mixture is halfway between the saturated liquid and saturated vapor temperatures."* **False.** In a given mixture at equilibrium, the temperature is the saturation temperature (the same for liquid and vapor) – quality doesn't change the temperature or pressure; it only changes the proportions of phases and thus mixture properties like average enthalpy or specific volume.

Exam Handbook Search Cues (Not affiliated with or endorsed by NCEES): saturated liquid; saturated vapor; quality; two-phase mixture; v_f, v_g, h_f, h_g; saturation temperature/pressure

Variations, Related Concepts:

- Sometimes instead of "quality", you might see the term "**dryness fraction**" (especially in older texts) – it's the same thing as quality (fraction that is vapor). A "dry" steam of 90% dryness means $x = 0.9$.
- **Latent heat:** The amount of energy required to completely vaporize a unit mass of liquid at saturation is $h_{fg} = h_g - h_f$. For water at 1 atm, $h_{fg} \approx 2256$ kJ/kg (that's the famous 540 cal/g or 970 Btu/lb in other units). This latent heat drops as pressure rises, reaching zero at the critical point. Values of h_{fg}, v_{fg}, etc., can be read from steam tables and are useful in calculations (e.g., energy required to boil off a certain mass).
- **Critical point:** At the critical pressure and temperature (for water, $P_c \approx 22.06$ MPa, $T_c \approx 374°C$), the distinction between liquid and vapor disappears (v_f and v_g converge). Above this point, there is no two-phase equilibrium – you have a supercritical fluid. Quality is not defined beyond the critical point because there is no separate liquid/vapor phase.
- **Subcooled (compressed) liquid and Superheated vapor:** If a liquid is at a given temperature below its boiling point for the pressure, it's subcooled (quality doesn't apply, x would be "negative" if you tried to compute). If a vapor is at a temperature above saturation for the pressure, it's superheated (quality notionally > 1, but again not used). For those, you'd use either compressed liquid approximations or superheated tables, not the mixture formulas.

Explanation & Analysis:

When solving FE problems involving phase change, the first step is often to identify what phase or region you're dealing with: - If they give you pressure and temperature for water (or a refrigerant), compare the temperature to the saturation temperature at that pressure (using provided tables or known values). If $T = T_{sat}$, you're on the saturation line – likely a mixture if not explicitly all liquid or all vapor. If $T < T_{sat}$, you have a subcooled liquid (x doesn't apply, treat it basically as liquid). If $T > T_{sat}$, you have a superheated vapor (x doesn't apply, it's all vapor beyond saturation). - If they give you pressure and a property like specific volume or enthalpy, you determine the phase by comparing that property to sat liquid and sat vapor values at that pressure. For example, at 1 MPa, v_f (sat. liquid specific vol) is about 0.001127 m³/kg and v_g is about 0.1943 m³/kg (just approximate numbers). If your given specific volume is 0.05 m³/kg at 1 MPa, you see it lies between v_f and v_g – that implies a mixture and you can find quality by interpolating: $x = \frac{v - v_f}{v_g - v_f}$. Then you could find other properties

similarly. - Quality is especially important for enthalpy interpolation: many energy balance problems in vapor power cycles (Rankine cycles) involve finding the enthalpy of steam with a given quality (e.g., steam exiting a turbine at 90% quality: you'd take $h = h_f + 0.9\, h_{fg}$ at that pressure).

For a concrete example: *"Saturated water at 150 kPa has 20% quality. Find the specific volume."* You'd go to steam tables, find at 150 kPa (which is $T_{sat} \approx 111.4°C$): $v_f \approx 0.00109$ m³/kg, $v_g \approx 1.1593$ m³/kg (numbers for illustration). Then $v = (1 - 0.2)0.00109 + 0.21.1593 \approx 0.232$ m³/kg. Most of that volume comes from the vapor portion even though vapor is only 20% of the mass – a vivid demonstration of why quality is mass-based. If instead the question gave you the specific volume and asked for quality, you'd rearrange: $x = \frac{v - v_f}{v_g - v_f}$.

Another typical situation: *"Steam at 1 MPa has a specific enthalpy of 2500 kJ/kg. Determine its quality."* At 1 MPa, from tables: $h_f \approx 762\ kJ/kg$, $h_g \approx 2778\ kJ/kg$. If the mixture's enthalpy is 2500, that's between h_f and h_g. Quality $x = \frac{h - h_f}{h_g - h_f} = \frac{2500 - 762}{2778 - 762} \approx 0.85$ or 85%. This means it's 85% vapor by mass (and 15% liquid) at 1 MPa, which in context might be steam exiting a turbine (wet steam).

Always remember: during a phase change at constant P (boiling/condensing), temperature stays fixed at T_{sat} and vice versa for constant T. So you won't, for instance, add heat to a boiling pot of water at 1 atm and see the temperature rise – it stays at 100°C until all water is vaporized (quality goes from 0 to 1). In calculations, that means if you're told something is a "saturated mixture at X °C", the pressure is automatically the saturation pressure at that temperature. You have one degree of freedom less when under the dome.

Quality is a simple concept but very powerful in thermodynamic calculations – it essentially parameterizes the linear interpolation between two extreme states (all liquid vs all vapor). Be sure to use it only in that context. Once you have quality and one intensive property like pressure (or temperature), you can find all the other mixture properties by interpolation as shown, using the data from property tables.

K11.T01.S05 – Thermodynamic Property Diagrams and Phase Regions

Diagram Passport: P–v Diagram (Pressure vs. Specific Volume) for a Pure Substance

- **Diagram Title and Role:** Pressure–Volume diagram – helps visualize phase behavior of a substance. It shows how pressure relates to specific volume at various temperatures, and clearly delineates the regions of liquid, two-phase mixture, and vapor. You use this to qualitatively assess how a process (like compression or expansion) moves a state through different phases, and to identify critical points, etc.

- **Axes and Quantities:** The vertical axis is **Pressure (P)**, often on a logarithmic scale to cover many orders of magnitude. The horizontal axis is **Specific Volume (v)** on a log scale as well (since specific volume of vapor can be hundreds or thousands of times that of liquid). Pressure increases upward; specific volume increases to the right. On such a diagram, isotherms (lines of constant temperature) can be drawn: at low temperatures they have a distinct flat segment (phase change), at the critical temperature the isotherm just touches the dome's peak, and above the critical temperature, isotherms are smooth curves without flat segments.

- **Key Regions and Boundaries:** The most prominent feature is the **saturation dome** (the blue curve in the diagram) which has two boundary lines:

- The **saturated liquid line** (left-hand side of the dome): it's where the substance is 100% liquid but any addition of heat (at constant P) will start vaporizing it.
- The **saturated vapor line** (right-hand side of the dome): where the substance is 100% vapor but any removal of heat will start condensing it. These two lines meet at the **critical point** (top of the dome). Underneath the dome is the **two-phase region** (liquid + vapor mixture). To the left of the dome is the **compressed (or subcooled) liquid region** – here the substance is liquid at a pressure higher than saturation for a given temperature. To the right of the dome is the **superheated vapor region** – vapor at a temperature above the boiling point for that pressure (or at pressure below saturation for that temperature).

On a P–v diagram, an isotherm below critical temperature (like the red dashed line for T below T_c) will: - drop steeply in the liquid region (since liquids are nearly incompressible, v doesn't change much with big P changes), - then flatten into a horizontal line across the two-phase region (phase change at constant P for that T), - then continue dropping in the vapor region (where gas follows something like $P \propto 1/v$ roughly). The length of that flat line is v_{fg}, the difference between saturated vapor and liquid specific volumes at that temperature. At higher T, that flat line shrinks (liquid and vapor properties get closer) until it disappears at the critical point.

How to Read it (Exam-style): Typically, you'd use such diagrams qualitatively. For instance, if a question says "sketch the process of isothermal vaporization of water at 120°C on a P–v diagram," you'd draw a horizontal line at $T = 120°C$ spanning from saturated liquid to saturated vapor at 120°C's saturation pressure (~202 kPa). Or if asked "what happens to pressure as a saturated mixture at constant volume is heated?," you can imagine a vertical line (constant v) on the P–v chart intersecting the dome. At first, if volume is between v_f and v_g, increasing T (heating) increases pressure (goes up along a constant-v line in two-phase region until reaching the saturated vapor line where all liquid is gone, then enters superheated region). Understanding these regions helps in reasoning what phase a substance is in given P–v (or T–v, etc.) data.

Common Misreads/Misconceptions: One common confusion is mixing up P–v and T–v diagrams. On a **T–v diagram**, the dome exists too, but isotherms and isobars swap roles: in T–v, horizontal lines represent isothermal processes (phase change at constant T). Under the saturation dome, pressure and temperature are linked (Psat ↔ Tsat). Therefore, boiling/condensation at saturation occurs at constant T and constant P. On a T–v diagram it appears as a horizontal segment at Tsat (since T is constant while v changes). Vertical lines on T–v represent constant specific volume, not constant pressure. On a **P–v diagram** (like above), it's reversed: horizontal lines are constant temperature during phase change, and vertical lines would be constant volume processes. Another pitfall: not recognizing the logarithmic scale – equal spacing on the axis might mean a 10x change. If one is reading actual values, be cautious. Also, sometimes students think "quality lines" (lines of

constant x) are straight – in reality, on P–v or T–v they are usually drawn as curved lines inside the dome connecting points of equal quality; but qualitatively, any point under the dome can be described by a quality.

Beyond P–v, there are other important diagrams:

- **T–v diagram:** Similar dome shape but axes are temperature vs specific volume. Here, constant pressure lines would be horizontal during phase change (since at given P, T is constant through the mixture). The regions (subcooled, two-phase, superheated) appear similar.

- **T–s diagram:** Temperature vs Entropy. This is very useful for visualizing thermodynamic cycles (Carnot, Rankine). The saturation dome appears here too (with saturated liquid line and saturated vapor line). Under the dome, quality increases from left to right (entropy of vapor > entropy of liquid). Isentropic processes are vertical lines on T–s. Heat addition can be seen as area under process curve on T–s (for a reversible process). Key point: on a T–s diagram, constant pressure lines go up and to the right through the two-phase region. In the two-phase region on a T–s diagram, an isobaric phase-change process is a horizontal segment at T_{sat}(temperature constant) while entropy increases as heat is added. In the superheated region, isobars slope upward/right.

- **h–s diagram (Mollier chart):** Enthalpy vs Entropy. Engineers use this for steam turbines, nozzles, etc. The saturation line is a curve on this chart. Constant pressure lines are typically drawn on it (for steam, they swoop downward as you go to lower entropy). The h–s diagram is great for quickly finding final states in adiabatic processes (vertical moves mean no heat loss/gain) or for reading quality and enthalpy after expansion without fiddling with tables too much. The FE Handbook provides a Mollier chart for steam – you might use it qualitatively or to interpolate values if needed, but often tables suffice.

In exam practice, you should know the general layout: *Under the dome = mixture.* Left of dome = all liquid. Right of dome = all vapor. At a given pressure, moving right means increasing specific volume (eventually hitting vapor). At a given temperature, moving right on T–v means hitting vapor. Each of these diagrams is just a different projection of the same "steam dome" in 3D space (P–v–T surface). So they contain the same information in different ways. If you're a visual thinker, sketching a quick T–s or P–v diagram in a phase-change problem can guide you to avoid unphysical answers (like a process that should have constant T during boiling, etc.). And of course, critical point is the cap – beyond that, no sharp phase change.

Exam Handbook Search Cues (Not affiliated with or endorsed by NCEES): phase diagram; P-v diagram; T-s diagram; phase envelope; Mollier chart; saturated dome; critical point

Common Exam Usage: You might not be asked to draw one, but you could be asked conceptually: "On a T–s diagram, where does process X end up?" or "Identify the region for given P, v," etc. The diagrams in the handbook (like the Mollier chart) can be directly used to get numbers (e.g. enthalpy at a given state if tables are not convenient). For example, if state is superheated and you have enthalpy and pressure, you can mark it on an h–s chart and read quality or entropy. So familiarity with reading such charts is useful. They might also test conceptual understanding: e.g. *"What happens to the boiling temperature of water as pressure increases?"* (From a P–T perspective, as pressure increases, boiling T increases – that's moving along the saturation curve.) Or *"What is the critical point?"* – the diagrams illustrate that.

Understanding these diagrams fortifies your understanding of saturation and quality, ensuring you won't make mistakes like assuming pressure changes in a boiler at fixed temperature, or mis-identifying a two-phase state as superheated. So while solving problems, if something seems off, sometimes a quick mental picture of these diagrams sets you straight.

K11.T01.S06 – Thermodynamic Property Tables (Steam Tables Usage)

Principle Introduction (Background Theory):

- **Property Tables:** Because equations of state for substances like water in the two-phase region (or even in the superheated region) can be complex, engineers rely on **thermodynamic property tables**. The FE Exam provides **steam tables** for water (likely in both SI and US units) covering:
- **Saturated Water Tables:** Properties of water at various saturation temperatures and pressures. Typically, one table is organized by temperature (each entry gives P_{sat} and the values of $v_f, v_g, u_f, u_g, h_f, h_g, s_f, s_g$, etc., at that temperature), and another by pressure (each entry gives T_{sat} and the same property values at that pressure). These tables cover from very low pressure (near vacuum) up to the critical point.
- **Superheated Steam Tables:** For water vapor at pressures below the critical and at temperatures above T_{sat} at those pressures. These tables are typically structured with pressure as the primary entry (like sections for 0.1 MPa, 0.2 MPa, 1 MPa, etc.), and temperature increments across or down the table. They list properties of superheated vapor: v, u, h, s at those P–T combinations.
- (The handbook may also include compressed liquid water approximations or a note that compressed liquid properties at a given T are approximately those of saturated liquid at that T, since liquid is relatively incompressible.)

How to Read and Interpolate: To use these tables:

- First, identify what data you know (P, T, or x, or a combination) and what you need.
- If you have a saturated mixture (quality given, or state described as "saturated at X"), you'll use the saturated tables. For example, "water at 150°C, quality 0.4" – go to the saturated table by temperature, find the row for 150°C, extract $v_f, v_g, h_f, h_g, s_f, s_g$ for 150°C. Then compute the requested property by linear interpolation: e.g. specific enthalpy $h = h_f + 0.4(h_g - h_f)$. No further interpolation between rows is needed since you landed exactly on 150°C row.
- If you have a pressure that isn't exactly in the table, or a temperature between listed entries, you'll have to **interpolate** linearly. For instance, "sat. water at 105°C" and the table jumps from 100°C to 110°C. You interpolate the values between those temperatures. Linear interpolation is generally accurate for small intervals in these tables (and expected if needed on the exam). The

exam might design problems such that you hit exact table values to save time, but be prepared to interpolate.

- For superheated states, if you're given P and T, find the corresponding pressure section, then see if the given T falls between two tabulated temperatures. Interpolate in that pressure's table. If given P and v or h, you might need to iterate or interpolate to find which T yields that property – more likely, they would give you direct T or a straightforward case.
- **Do not extrapolate** beyond the table range: e.g., if the highest temperature given at 2 MPa is 400°C and your problem asks about 500°C at 2 MPa, beware – 500°C might not be in the provided tables (the exam likely avoids such a scenario or expects you to note it's superheated beyond table range). In reality, you'd then either use ideal gas approx or be given another source. But on the FE, typically all needed data is available in the provided tables/diagrams or can be reasoned through.

- **Units and Source Lineage:** The tables in the exam reference are likely adapted from well-known sources (like the IAPWS or similar for water). They present data in either SI or USCS units (often both, but in separate tables). Each column has units noted (e.g., v_f in m³/kg, h_f in kJ/kg, s_f in kJ/(kg·K) for SI). It's crucial to use the correct table (don't mix values from the SI table into a US units problem or vice versa!). The tables in our study materials here are *original summaries/redrawn versions* for learning purposes – they are not verbatim from the handbook, but they reflect the same information so you can practice. Always double-check you're reading, say, *kJ/kg vs Btu/lbm*, because mixing those will cause a huge numerical discrepancy.

In this excerpt, at 100°C (the normal boiling point), $P_{sat} = 101.3$ kPa. The specific volume of liquid v_f is 0.001043 m³/kg (very small, liquids are dense), and of vapor v_g is 1.673 m³/kg (about 1600 times larger). The enthalpy of saturated liquid h_f is 419.0 kJ/kg (that's how much energy per kg is in liquid water at 100°C reference to 0°C water), and enthalpy of vapor h_g is 2676.0 kJ/kg. The difference $h_{fg} = 2257$ kJ/kg is the latent heat. Entropies s_f and s_g likewise show a big jump (6.05 kJ/kg·K increase when vaporizing at 100°C). At 150°C, because pressure is higher, h_{fg} has decreased (2725.9–640.2 ≈ 2085.7 kJ/kg), etc. You can see as temperature rises, v_g shrinks and liquid h_f increases while h_g doesn't rise as fast, narrowing the gap.

Typical Exam Moves:

- **Lookup and interpolate:** A problem states "steam at 1.5 MPa and 250°C – find its specific enthalpy." You identify it's superheated (250°C > sat temperature at 1.5 MPa which is ~198°C). So you go to the superheated table at P = 1.5 MPa, find enthalpy at 250°C (maybe it lies between 240°C and 260°C entries, so you interpolate). Then use that enthalpy in an energy equation.
- **Quality calculation:** "Steam at 200 kPa has specific internal energy 2200 kJ/kg, find quality." You'd go to saturated table at 200 kPa (or corresponding Tsat ~120°C), get u_f and u_g, and interpolate: $x = (u - u_f)/(u_g - u_f)$. Then maybe find enthalpy or volume using that x.
- **Identify state:** Given two properties, determine state. E.g., given P = 500 kPa and v = 0.1 m³/kg, you check sat table at 500 kPa: $v_f \approx 0.0011, v_g \approx 0.374$. Since 0.1 is much larger than v_f and about a quarter of the way to v_g, it means mixture with quality ~ (0.1-0.0011)/(0.374-0.0011) ~ 0.264 (26.4% vapor). So state is saturated mixture, not superheated.
- **Using superheated tables:** If given P and T in the superheated region, just pick off values. If given P and one of {v, u, h, s} in superheated, you might have to find which T yields that (could involve interpolation or slight trial).
- **Using compressed liquid:** Often the exam skirts detailed compressed liquid properties by either (a) assuming compressed liquid at T is approx. the same as saturated liquid at that T (a handy approximation: e.g., water at 20°C and 5 MPa has enthalpy ~ hf at 20°C because it's barely different from liquid at 0.101 MPa), or (b) giving you data or expecting you to realize internal energy change in liquid is $c\,\Delta\,T$ roughly.

Common Pitfalls:

- **Mixing up tables:** e.g. looking up a value in the saturated temperature table when you meant to use the pressure table, and grabbing the wrong row. Always double-check: if you have P given, you might go to the saturation pressure table for convenience (unless the exact pressure isn't listed but the corresponding Tsat is).
- **Reading the wrong column:** e.g. taking v_g when you meant v_f, or using h_g when the state is actually subcooled liquid (you should use h_f in that case or maybe interpolate in compressed region). If quality is given, use the formula rather than picking random columns.
- **Interpolation errors:** messing up the fraction or using nonlinear interpolation where it's linear. Within small ranges, linear is fine. Compute the fraction accurately: e.g., if v=0.1 is what fraction between 0.0011 and 0.374? (0.1-0.0011)/(0.374-0.0011). Pay attention to significant figures appropriately but don't over-round intermediate.
- **Unit conversion:** This bears repeating. The exam might give you an answer expectation in a certain unit. If you look up enthalpy in Btu/lbm but your calculations were in SI, you'll be off by a factor. Stick to one system per problem; the reference handbook typically separates them, but always confirm the units heading the table. For instance, "Enthalpy (Btu/lb)" vs "Enthalpy (kJ/kg)" – easy to notice if vigilant.
- **Quality > 1 or < 0:** If from a calc you get x outside [0,1], it means you assumed it was a mixture but it's actually superheated (x>1) or subcooled (x<0). In those cases, go to the appropriate table/approach. For example, if x computes to 1.1, it means the state is superheated vapor (all vapor and then some, the number basically indicates how far beyond hg it is). You'd then use superheated data at that pressure.

Exam Handbook Search Cues (Not affiliated with or endorsed by NCEES): steam tables; saturated water; superheated steam; properties of water; interpolation

Special Notes (Calculator): Interpolation can be done quickly on the FE-approved calculators. You can do it stepwise or use the built-in linear interpolation function if available (some calculators

have it as a feature). But usually, it's simple enough: compute the difference ratio and multiply by interval. Also, some values in USCS might be given in Btu/lbm and you might need to convert to, say, ft·lbf/lbm for using in some equation (since 1 Btu = 778 ft·lbf). However, it's unlikely you need to do that on the FE; they'd likely keep things consistent (or ask conceptually). Just be aware of the unit equivalences given in the handbook for any needed conversion.

Explanation & Analysis:

Let's walk through a brief example using tables to solidify understanding: Suppose a question asks, *"How much heat is required to vaporize 5 kg of water initially at 40°C to steam at 40°C and quality 100% (dry steam) at 1 atm?"* You identify this as a constant-pressure process at 1 atm (101.3 kPa) with initial state: water 40°C (subcooled liquid) and final state: saturated vapor at 100°C (boiling point at 1 atm) – wait, 40°C to 100°C is heating then boiling. So break it into two steps: heat from 40°C to 100°C (sensible heat), and then phase change from liquid to vapor at 100°C. Using tables: at 1 atm, $h_f(40°C)$ ~ we can approximate using $c\,\Delta\,T$ since 40°C sat pressure is only 7.4 kPa – or use compressed liquid approximation $h_{liq@40°C} \approx h_{f@40°C}$ (some tables give values for subcooled or we use sat at 40°C even though sat pressure is much lower, the enthalpy difference due to pressure is minor). $h_f(40°C) \approx 167.5$ kJ/kg (just an estimate). At 100°C, $h_f(100°C) = 419.0$ kJ/kg, $h_g(100°C) = 2676.0$ kJ/kg. So for 1 kg, heating liquid 40→100°C takes ~$(419 - 167.5) = 251.5$ kJ/kg. Boiling that 1 kg at 100°C takes $h_{fg}(100°C) = 2257$ kJ/kg. Sum = 2508.5 kJ/kg. For 5 kg, Q ≈ 12,542.5 kJ. You'd get full points by showing the usage of values from tables (they might provide the needed enthalpies in the problem or expect you to get them from the handbook). This is a classic use of tables: pick initial enthalpy, final enthalpy, subtract.

Another scenario: reading superheated properties. If asked, "Determine the entropy of steam at 10 MPa and 500°C," we go to superheated steam table at 10 MPa. Say at 10 MPa, 500°C, $s \approx$ 6.59 kJ/(kg·K) (just making up a likely number). You'd find it in the row of 500°C under 10 MPa section. If the question gave something like 480°C, you might interpolate between 460°C and 500°C entries.

In summary, steam tables are your quantitative tool to get actual numbers for water and similar substances. They complement the conceptual understanding from diagrams. During the exam, identify which table is appropriate, carefully extract or interpolate the values, and plug them into your formulas (like energy balances, process calculations, etc.). With practice, this becomes a quick lookup process. The tables in the exam are arranged for convenience – use the index or labels in the handbook (e.g., "Saturated Water – Temperature Table") to jump to the right page quickly. Efficiency in navigating the tables can save precious minutes.

K11.T01.S07 – Ideal Gas Mixtures and Partial Pressures

Principle Introduction (Background Theory):

Ideal Gas Mixtures: A mixture of non-reacting ideal gases (e.g., air, which is a mixture of N_2, O_2, etc.) behaves in many ways like a single ideal gas, but you have to account for the contribution of each constituent. Key concepts:

- Each gas in the mixture obeys the ideal gas law on its own: $P_i\,V = m_i\,R_i\,T$. All gases in the mixture share the **same volume V** and **temperature T** (if they are well mixed and in equilibrium).
- The **total pressure P** of the mixture is the sum of the **partial pressures** of each component: **Dalton's Law of Partial Pressures** states $P = P_1 + P_2 + \cdots + P_n$. Here P_i is the pressure that gas *i* would exert if it alone occupied the volume at the mixture temperature (keeping the same volume and temperature).
- The **partial pressure** can be calculated as $P_i = y_i\,P$ if y_i is the **mole fraction** of gas i in the mixture (since partial pressure ratio equals mole fraction for ideal gases). Equivalently, $P_i = x_i\,P$ where x_i denotes mole fraction (using x as mole fraction notation, consistent with the reference). Be careful: some texts use y for mole fraction, but here we'll say $x_i = \frac{N_i}{N_{\text{total}}}$ in moles and $y_i = \frac{m_i}{m_{\text{total}}}$ in mass.
- **Mole Fraction vs Mass Fraction:** If N_i is number of moles of component i, the mole fraction $x_i = N_i/N_{\text{total}}$. If m_i is the mass, the mass fraction $y_i = m_i/m_{\text{total}}$. Mole fractions sum to 1, and mass fractions sum to 1. They are related by molecular weights: $y_i = x_i\,\frac{M_i}{\bar{M}}$, where $\bar{M}$ is the average molecular weight of the mixture.
- **Mixture Molecular Weight:** (mole-fraction-weighted average of molecular weights). This is useful: for air, $\bar{M} \approx 28.97$ kg/kmol as mentioned.
- **Mixture Gas Constant:** $R_{\text{mix}} = \frac{R_u}{\bar{M}}$. Or you can compute using mass fractions: the mixture's gas constant can also be seen from $P\,V = m\,R_{\text{mix}}\,T$ and $m = \sum m_i$, $P = \sum P_i$. In fact, since $P_i = (m_i R_i T)/V$, summing gives $P = \frac{T}{V}\sum m_i\,R_i$. But $R_i = R_u/M_i$. It can be shown $R_{\text{mix}} = \sum y_i\,R_i$ (mass fraction weighted) which should equal $R_u/\bar{M}$, consistent since $y_i = \frac{x_i\,M_i}{\bar{M}}$.
- **Dalton's Law Application:** If you know the mixture composition by percent (mole or volume percentage for gases are the same concept under ideal conditions), you can find partial pressures by multiplying total pressure by those fractions. For example, at atmospheric pressure (101.3 kPa), if a gas is 21% O_2 and 79% N_2 by volume (which is basically air), then partial pressure of O_2 is 0.21 * 101.3 ≈ 21.3 kPa, N_2 ~80.0 kPa. Dalton's law assumes each gas behaves ideally and doesn't interact (which is reasonable for most mixtures of gases at low pressure).
- **Mixture Specific Heats:** If each component has known $c_{p,i}$ and $c_{v,i}$, the mixture's effective specific heats can be found by weighting with mass fraction: $c_{p,\text{mix}} = \sum_i y_i\;c_{p,i}, c_{v,\text{mix}} = \sum_i y_i\;c_{v,i}$.This makes sense since enthalpy per mass of mixture is the sum of each component's enthalpy per mass of mixture: $h_{\text{mix}} = \sum_i y_i\,h_i$, and differentiating with respect to Tyields the above if each $\frac{\mathrm{d}h_i}{\mathrm{d}T} = c_{p,i}$. Similarly, for internal energy we have $u_{\text{mix}} = \sum_i y_i\,u_i$and $\frac{\mathrm{d}u_i}{\mathrm{d}T} = c_{v,i}$. The mixture specific heat ratio $k_{\text{mix}} = c_{p,\text{mix}}/c_{v,\text{mix}}$ can be computed after those, or you can mole-fraction weight if appropriate (for constant molar specific heats).
- **Other Properties:** Mixture internal energy u, enthalpy h, entropy s per mass can also be found by mass-weighted sums. E.g., $u_{\text{mix}} = \sum y_i\,u_i$ (with each u_i taken at the mixture temperature for that gas). Enthalpy same way. Entropy for ideal gas mixtures is a bit tricky because entropy has mixing effects (if considering entropy on a

per mole basis with mixing, you add $-R_u \sum x_i \ln x_i$ etc., but if you just weight the specific entropies of components at their partial pressures, you can use $s_{\text{mix}} = \sum y_i\, s_i(T, P_i)$, effectively accounting for each gas entropy at its partial pressure).

- **Dry Air and Humidity (just a note):** Though not explicitly in the outline, a common application is moist air: a mixture of dry air and water vapor. Dalton's law is used: total pressure = dry air partial + water vapor partial. The humidity ratio and relative humidity concepts stem from partial pressures (but that might be covered in HVAC section). Just keep in mind ideal mixture principles apply there too.

Equation Passport: Ideal Gas Mixture Relations

- **Name and Purpose: Ideal Gas Mixture Relations** – set of formulas to determine mixture properties like partial pressures, average molecular weight, and specific heats of a non-reacting gas mixture. They allow you to treat a gas mixture systematically rather than analyzing each component with separate volumes.

Core Formulas:

- *Dalton's Law:* where P_i (partial pressure of i) satisfies $P_i\, V = m_i\, R_i\, T$. Equivalently, $P_i = x_i\, P$ (with $x_i = N_i/N$ mole fraction). Also $V_i = V\, x_i$ (each gas i occupies a fraction of volume equal to its mole fraction, if at same T,P – this is Amagat's law of partial volumes, which for ideal gases is analogous).

- *Molecular Weight:* (kg/kmol or similar units). And $R_{\text{mix}} = R_u/\bar{M}$.

- *Mass/Mole Fractions:* $y_i = \frac{m_i}{m_{\text{total}}}$, $x_i = \frac{N_i}{N_{\text{total}}}$, and the conversion $y_i = x_i\, \frac{M_i}{\bar{M}}$.

- *Mixture Specific Heats:* $c_{p,\text{mix}} = \sum_i y_i\, c_{p,i}$, $c_{v,\text{mix}} = \sum_i y_i\, c_{v,i}$.

(And by extension, $h_{\text{mix}} = \sum y_i\, h_i, u_{\text{mix}} = \sum y_i\, u_i$ at the same T, with each property taken at that T.)

Variables and Units:

- P = total pressure of mixture (Pa, atm, etc.), P_i = partial pressure of component i (same units as P).
- V = total volume (m³, etc.) occupied by the mixture.
- m_i = mass of component i (kg), $m_{\text{total}} = \sum_i m_i$.
- N_i = number of moles of i (kmol), $N_{\text{total}} = \sum N_i$.
- M_i = molecular weight (kg/kmol) of component i.
- x_i = mole fraction of i (dimensionless), y_i = mass fraction of i (dimensionless).
- R_i = specific gas constant for component i = R_u/M_i (J/(kg·K)). $R_{\text{mix}} = R_u/\bar{M}$.
- $c_{p,i}, c_{v,i}$ = specific heats of component i (J/(kg·K)), assumed at the mixture's T (since ideal gas internal energy/enthalpy depends only on T).
- All extensive properties (mass, moles) add; intensive properties (like specific heats) are weighted averages as above.

Assumptions and Scope:

- Each component gas is ideal and the mixture is well-mixed (uniform T throughout, no chemical reactions between components).
- No volume change on mixing aside from additive (ideal gases don't shrink or expand oddly when mixed; they behave as if each occupies the full volume).
- The mixture is non-reactive (if a reaction occurs, the composition changes and you'd handle it differently).
- The formulas assume the mixture behaves ideally as well, which is generally true if each component is ideal and there's no significant interaction (good at low pressures).
- For specific heats: assumes no energy interaction beyond each gas's contribution (true if non-reacting and ideal). Note that $c_p - c_v = R$ holds for each gas and also for the mixture using mixture values (can be proven by linear combination as well).

Limit Tests and Checks:

- If one component dominates (say 99% one gas and 1% another by moles), the mixture molecular weight and c_p will be almost the dominant's values. Partial pressures: the dominant gas has $P_1 \approx P$, the trace gas has $P_2 \approx 0.01\, P$. That aligns with expectation.
- If you have a pure gas (only one component), then $x_1 = 1$, and the formulas reduce: $\bar{M} = M_1$, $R_{\text{mix}} = R_1$, $c_{p,\text{mix}} = c_{p,1}$, etc., and partial pressure $P_1 = P$ – trivial consistency check.
- The sum of partial pressures equals total – if you computed partials individually and summing doesn't match total due to rounding, check the fractions. On an exam problem, they usually keep it tidy or expect a slight rounding tolerance.
- A subtle check: The entropy of a mixture is not simply $\sum y_i\, s_i(T, P)$ if you consider mixing process – mixing increases entropy beyond the weighted sum due to combinatorial mixing entropy. However, if each s_i is taken at partial pressure P_i, then $s_{\text{mix}} = \sum y_i\, [s_i^\circ(T) + R_i \ln(P_i/P^\circ)]$ which effectively accounts for mixing (but that's beyond what FE likely requires; usually you won't need to calculate mixture entropy change unless it's an ideal gas mixing problem in thermo second-law context).

- **Use vs. Sibling Equations:** Use these mixture formulas instead of treating each gas separately when you need overall properties like mean molecular weight or when applying the ideal gas law to a mixture ($P\, V = m\, R_{\text{mix}}\, T$ works if you find R_{mix} via composition). If dealing with gas mixtures where chemical reactions happen (e.g. combustion), you'd combine these with reaction stoichiometry (that's another topic). Also, if gas interaction is not negligible (like gas dissolving in liquid, etc.), then Dalton's law might not directly apply – but for FE Mechanical, think mostly simple gaseous mixtures.

Common Exam Traps:

- **Using mass fraction in Dalton's directly:** Dalton's law $P_i = x_i\, P$. If they give composition in mass %, convert to mole fraction first. For example, 50% CO_2 and 50% O_2 by mass is not 50/50 by mole (CO_2 is heavier, so mole % CO_2 will be smaller).

- **Confusing y_i vs x_i:** The exam might explicitly say "on a molar basis" or "by volume." "By volume" for gases ~ "by mole" because at equal T,P, volumes ratio = moles ratio. So 30% by volume CO_2 means $x_{CO2} = 0.3$.
- **Mixing units in R:** If you use $\bar{M}$ in kg/kmol and $R_u = 8.314\text{kJ}/(\text{kmol} \cdot \text{K})$ (note kJ), you must be consistent in units. Safer: use $R_u = 8314\text{J}/(\text{kmol} \cdot \text{K})$ and $\bar{M}$ in kg/kmol to get R_{mix} in J/(kg·K).
- **Forgetting partial pressure is on absolute scale:** e.g. if asked the partial pressure of oxygen in air, you use total absolute pressure. If total given as 1 atm, $P_{O2} = 0.21$ atm, which is about 0.21 * 101.3 =21.3 kPa (abs). Not 0.21 * (101.3- maybe someone might subtract ambient? No – in mixtures we always deal in absolute).
- **Applying mixture formulas to liquids/solids:** They don't apply! (At least not in this simple form.) So if a problem sneaks in something like a liquid mixture, Dalton's law doesn't hold (that would need Raoult's etc., outside FE scope likely).

Exam Handbook Search Cues (Not affiliated with or endorsed by NCEES): partial pressure; Dalton's law; ideal gas mixture; mole fraction; molecular weight; specific heat of mixture

Variations and Practical Examples:

- **Mean Molecular Weight Example:** Given a gas mixture of 50% N_2 (M=28) and 50% CO_2 (M=44) by moles, $\bar{M} = 0.528 + 0.544 = 36$. If it's 50/50 by mass instead, that means out of 1 kg, 0.5 kg N_2 and 0.5 kg CO_2. Moles of N_2 =0.5/28=0.01786 kmol, moles of CO_2=0.5/44=0.01136 kmol, total 0.02922 kmol. Mole fractions: N_2 0.01786/0.02922=0.611, CO_2=0.389. Then $\bar{M} = 0.61128 + 0.38944 \approx 34.9$. Note difference – mass vs mole fraction changes the result.
- **Air mixture properties:** Air ~ 78% N_2, 21% O_2, 1% Ar by volume (mole). So $\bar{M} \approx 0.7828 + 0.2132 + 0.0140 = 28.96$ *kg/kmol. If asked for $c_{p,\text{air}}$, you can do mass-weighted: N_2 $c_p \approx 1.040$ kJ/kgK, O_2 $c_p \approx 0.918$ kJ/kgK, Ar $c_p \approx 0.520$ (monatomic). Weighted:* $0.781.040 + 0.210.918 + 0.010.520 \approx 1.01$ kJ/kgK (which is roughly known c_p of air). That consistency check is nice.
- **Partial pressure in container:** e.g. *"A rigid tank contains 2 kg of CO_2 and 5 kg of N_2 at 300 K, total pressure 800 kPa. Find the partial pressure of CO_2 and the volume of the tank."* We do $\bar{M}$ or directly partial: find moles: $n_{CO2} = 2/44 = 0.0455$ kmol, $n_{N2} = 5/28 = 0.1786$ kmol. $x_{CO2} = 0.0455/(0.2241) = 0.203$, $x_{N2} = 0.797$. Partial $P_{CO2} = 0.203800 = 162.4$ *kPa,* $P_{N2} = 637.6$ *kPa. Volume: use mixture ideal gas: total* $n = 0.2241$ *kmol,* $R_u = 8.314$ *kJ/(kmolK), T=300K,* $P = 800kPa = 800\text{kN/m}^2$. *Convert units properly:* R_u *in J: 8314 J/(kmolK).* $PV = nR_uT \Rightarrow V = nR_uT/P = 0.22418314300/(800000)$. *Compute: 0.2241*8314=1862, *300=558600, /800000=0.698 m³. Alternatively, find $R_{\text{mix}} = (y_{CO2}R_{CO2} + y_{N2}R_{N2})$ and do $P\,V = m\,R_{\text{mix}}\,T$. Either works if careful.
- **Mixture entropy (concept):** If a problem asks the increase in entropy when two ideal gases mix, you can compute using partial pressures: $\Delta S = -R_u \sum N_i \ln(x_i)$ (for isothermal mixing, classic formula). Not super common in FE, but if needed, the handbook might have a blurb. Usually, they won't go there in depth for FE Mechanical.

Explanation & Analysis:

Treating gas mixtures involves a bit of bookkeeping but it's straightforward with ideal gas assumptions. Dalton's law essentially says each gas in a mixture is oblivious to the others when it comes to pressure contribution – they all jostle around and contribute to pressure proportionally to their amount (moles). This is because pressure is essentially due to collisions of molecules; each type collides and adds pressure independently.

The typical FE problem might require computing the properties of a combustion exhaust (mix of CO_2, O_2, N_2, etc.) or just something like finding the partial pressure of water vapor in moist air given relative humidity (which is partial pressure concept). Or a simpler one: given a tank with a known mass of two gases, find total pressure or partial pressure after mixing.

One common application: **humidity** – e.g., "air at 25°C, 60% RH" means the partial pressure of water vapor is 0.6 times the saturation pressure of water at 25°C. Using Dalton's, you can find the actual water partial pressure, and by difference the partial pressure of dry air (since total is atmospheric). Then you can find humidity ratio, etc. While that might be covered under HVAC, it is a direct use of these principles.

Another: **flue gas or air-fuel ratio** problems. E.g., "Combustion products contain 10% CO_2, 5% O_2, 85% N_2 by volume. If total pressure is 1 atm, what is the partial pressure of O_2?" Answer: 0.05 atm. Or they may ask for dew point of the gas which involves partial pressure of water equals saturation pressure at dew point.

To solve mixture problems efficiently: - If given percentages by volume, directly treat them as mole fractions x_i for gas problems. - Convert to mass fractions if needed for specific heats or if using m in equations. - Use partial pressures to handle things like each gas's contribution to ideal gas law. Alternatively, sometimes easier: use total m and R_{mix}: $P\,V = m_{\text{total}}\,R_{\text{mix}}\,T$. Confirm R_{mix} by $R_{\text{mix}} = \sum y_i\,R_i$. For our earlier example, $y_{CO2} = 2/(2+5) = 0.2857, y_{N2} = 0.7143$. $R_{CO2} = 188.9J/(kgK), R_{N2} = 296.8J/(kgK)$. Then $R_{\text{mix}} = 0.2857188.9 + 0.7143296.8 = 266.0J/(kgK)$. $m = 7\,kg, P = 800000\,Pa, T = 300K$. $V = mR_{\text{mix}}T/P = 7266300/800000 = 0.698m^3$, same result as before. Either method is fine.

Given the broad scope of FE, mixture questions are likely straightforward. But understanding these basics prevents mistakes. For example, if you forgot to use mole fraction for partial pressure, you'd get a wrong answer. Or if you incorrectly assumed 50% by mass = 50% by volume, you'd get partial pressure wrong.

Summary: Ideal gas mixture calculations revolve around using ratios (mass vs mole) properly and applying Dalton's law. Keep track of what basis your fractions are given in, and convert if necessary. The rest is plugging into $PV = mRT$ appropriately or computing weighted averages. With these tools, problems like "What is the average molecular weight of exhaust gas?" or "Find the partial pressure of component X" become plug-and-chug rather than head-scratchers. Always double-check that results make sense (e.g., partial pressures sum to total, weighted averages lie between extremes, etc.). That way, you can confidently handle any mixture question that comes your way on exam day.

Topic 02 - Energy Transfers

Topic Introduction:
Energy transfers in thermodynamics involve the movement or conversion of energy in the form of heat or work, as well as energy carried by mass entering or leaving systems. On the FE Mechanical Exam, understanding these transfers is vital for solving problems related to the First Law of Thermodynamics. Typical question scenarios include calculating the work done by a gas during expansion, finding the heat required to achieve a certain temperature change in a closed vessel, or determining the power needed for a pump or the exit velocity from a nozzle. Mastering this topic ensures you can confidently apply energy conservation principles to both **closed systems** (no mass exchange) and **open systems** (mass flow through control volumes) – a cornerstone skill for exam day. Common problem-solving moves involve identifying the system type, writing the appropriate energy balance, canceling out negligible terms (like ignoring kinetic energy change in a slowly moving fluid, or assuming no heat loss in an insulated device), and solving for the unknown. In short, this topic is all about bookkeeping energy so you can predict how systems heat up, cool down, or do work under various conditions.

K11.T02.S01 – First Law of Thermodynamics (Closed System)

Principle:

- The **First Law** states energy is conserved: energy added to a closed system as heat minus work done by the system equals the increase in the system's stored energy.

- For a closed system (no mass crossing the boundary), this stored energy is typically the **internal energy (U)** (plus any kinetic or potential energy if relevant).

- In many closed-system problems, we take changes in kinetic and potential energy to be negligible and focus mainly on the change in internal energy, ΔU.

- **Sign convention:** Heat Q added *into* the system is positive, and work W done *by* the system (outward, like pushing a piston) is positive. This convention ensures $Q - W$ represents the net energy retained by the system.

- This fundamental relationship underlies processes like heating/cooling in sealed vessels, gas expansion/compression in cylinders, and any situation where energy crosses the system's boundary only as heat or work.

First Law (Closed System) – *Relates heat input and work output to the change in a closed system's internal energy.*

$$\Delta U = Q - W$$

- ΔU**:** Change in the system's internal energy (J), i.e., the energy associated with molecular-level storage (the thermal/internal energy difference between the initial and final states).

- Q**:** Heat transferred *into* the system (J). If the system absorbs heat, Q is positive. Heat removed (leaving the system) would be a negative Q in this convention.

- W**:** Work done *by* the system (J). If the system expands and does work on its surroundings, W is positive. Work done *on* the system (compression) would make W negative in this formula (since it is work *by* the system with a negative value).

Assumptions and scope: Applies to **closed systems** (fixed mass, no mass enters or leaves). All energy transfer is as either heat or work across the system boundary. In many exam problems, kinetic and potential energy changes (ΔKE, ΔPE) are zero or negligible[^1] – in such cases, $Q - W$ solely equals ΔU. This equation holds for any process (reversible or not) as long as you carefully account for sign convention and energy forms. It's essentially an energy balance for the system: what comes in minus what goes out = change in stored energy.

Limit checks: If no heat or work is exchanged ($Q = 0$, $W = 0$), then $\Delta U = 0$ – the system's internal energy stays constant (no surprise: nothing done to the system means no energy change). If more heat is added than work done ($Q > W$), ΔU comes out positive – internal energy increases. Conversely, if the system does more work out than heat in ($W > Q$), ΔU is negative – internal energy decreases (e.g. an expanding gas cooling down if it does work without enough heat input). These checks help ensure you haven't flipped a sign: e.g. if you calculate a negative ΔU in a scenario where the system clearly gained energy, you likely misplaced a sign.

Use vs. related forms: Use this **closed-system first law** for sealed systems or non-flow processes (like piston–cylinder problems or sealed tanks). It is typically used in place of the steady-flow energy equation when the system is closed (no mass crosses the boundary). Note that for a cyclic process, the system returns to its initial state, so $\Delta U = 0$; therefore, over a complete cycle the net heat added to the system equals the net work produced by the system. In terms of related forms, sometimes you'll see this written per unit mass: $q - w = \Delta u$ (with lower-case q, w, u representing heat, work, internal energy *per unit mass*). It's the same equation normalized to mass. Use whichever form matches the data (total energy vs per mass). The key is consistency.

Common exam pitfalls:

- **Sign convention mistakes:** It's easy to get turned around on signs. For example, if the problem states work is done *on* the system, that means from the system's perspective W is negative (since our W is work done by the system). Always align with Q in (positive) and W out (positive) before plugging numbers in. A quick aid: write Q_{in} and W_{out} on your paper and assign positives/negatives according to the wording.

- **Forgetting unit consistency:** Ensure that Q, W, and ΔU are in the same units (e.g. all in J, or all in BTU). A common slip is mixing BTU and ft·lbf or J and kJ without proper conversion[^2]. The exam might, for instance, give heat in BTU and work in ft·lbf – you'd need to convert one (1 BTU = 778 ft·lbf). Keep an eye on units of specific heats too (e.g. c_v might be given in J/(kg·K) or in BTU/(lbm·°F)).

- **Mixing up energy forms:** Internal energy U is a property of the system's state (dependent on temperature, phase, etc.). Do not confuse it with **enthalpy** H (which is $U + PV$) – enthalpy is used for open systems (next subtopic). In closed systems, use internal energy for the stored energy change. Also, if kinetic or potential

energy changes *are* significant (like a fast-moving object or a big height change), include them in the energy balance; ignoring them when they matter will lead to errors. For example, if a problem involves a rapid projectile or a falling object in a thermodynamics context, you might need $\frac{1}{2}mV^2$ or $mg\Delta z$ terms in addition to ΔU.

Exam Handbook Search Cues (Not affiliated with or endorsed by NCEES): *First Law, internal energy (U), heat (Q), work (W), closed system energy equation*

Footnotes:

[^1]: *Kinetic/potential energy:* In a closed-system piston problem, the center of mass might not be moving significantly, and height changes are often negligible. Unless a problem explicitly involves a change in velocity (e.g. a moving cylinder or fluid jets) or height (e.g. a container lifted or dropped), you can safely take $\Delta KE = \Delta PE = 0$ on the exam, focusing only on internal energy.
[^2]: *Units note:* Internal energy is often tabulated per unit mass (e.g. kJ/kg or BTU/lbm). To use $\Delta U = Q - W$, either use total quantities in consistent units (J, ft·lbf, BTU, etc.) or multiply a per-mass Δu by the mass. For instance, if $\Delta u = 50$ kJ/kg for a 2 kg system, then $\Delta U = 100$ kJ. Also remember 1 BTU ≈ 1055 J (≈ 778 ft·lbf) when converting between SI and US units.

Explanation & Analysis: The closed-system first law is essentially an accounting balance for energy. It tells us that any heat you put into a system either stays in the system as increased internal energy or leaves the system as work done. To apply this equation in an exam problem, first identify the system boundaries and confirm no mass is crossing them (closed system). Next, list the energy interactions:

1. **Heat (Q):** Determine if heat is added or removed. For example, if a gas is heated in a rigid container, you have Q into the gas (positive). If something is cooling, Q might be negative (heat leaving the system). Sometimes, the problem states heat in terms of cooling water or an electrical heater – translate that into heat *into or out of* your system accordingly.
2. **Work (W):** Check if the system does work on its surroundings or vice versa. Common work modes are boundary work (e.g. a piston moving), shaft work (a stirrer or a turbine connected to the system), or electrical work (current passing through a resistor in the system). If volume doesn't change (rigid container) and no other device is doing work, then $W = 0$. If the system expands against a piston, W is positive (work done by system). If the system is compressed by an outside force, W is negative (since work is done *on* the system, not by it).
3. **Internal energy change (ΔU):** Relate this to temperature or phase change. Often for ideal gases, $\Delta U = mc_v\Delta T$. For other substances, you might use tables or given specific internal energy values. Once you determine Q and W (with proper sign), you can find $\Delta U = Q - W$. This tells you how much the internal energy changed; from there, you might solve for final temperature or pressure using thermodynamic relations. For instance, if ΔU for an ideal gas is found to be 200 kJ (increase) and you know m and c_v, you can find $\Delta T = \Delta U/(mc_v)$ to get the temperature rise.

Term-by-term, ΔU represents a change in the microscopic energy stored in the substance (thermal agitation of molecules, chemical energy bonds, etc.). Heat Q is energy in transit due to a temperature difference – think of it as "what the system absorbs from a hot source" (positive Q in). Work W is energy in transit associated with a force acting through a distance – think "what the system pushes out on something" (like moving a piston or spinning a shaft). The equation $\Delta U = Q - W$ basically says: *if you dump heat into the system, it has to either raise the internal energy or go out as work, or both.*

A common FE exam application is a **piston-cylinder** problem. For example, a gas is compressed (work done *on* the gas, so from the gas's perspective W is negative), and perhaps it loses some heat during compression (Q is negative, heat leaving). You might be asked for the change in internal energy or final temperature. By carefully assigning signs (say 100 kJ of work **on** the gas → $W = -100$ kJ, and 20 kJ of heat **lost** from the gas → $Q = -20$ kJ), the first law gives $\Delta U = Q - W = (-20) - (-100) = +80$ kJ. The positive result makes sense: the gas's internal energy increased (it warmed up overall) because more energy was added by compression than removed by cooling. Always do a gut check on sign logic: more energy in than out means internal energy should go up. If your calculation gave a negative ΔU in that scenario, you'd know you dropped a negative sign incorrectly.

Another scenario: **Rigid tank heating.** Suppose you have 5 kg of water in a rigid, sealed tank and you add 100 kJ of heat. The tank volume is constant, so no boundary work ($W = 0$). Then $\Delta U = Q - W = +100$ kJ. All that heat goes into increasing the water's internal energy (raising its temperature or partially vaporizing it). You could then divide by mass to get $\Delta u = 20$ kJ/kg, and use water tables to find the temperature increase or new state. This is straightforward since no work term to worry about.

One more check: if the problem describes a **cycle** (like a gas goes through several processes and returns to the starting state), then overall $\Delta U = 0$ for the whole cycle. In that case, $Q_{\text{net}} = W_{\text{net}}$. An exam question might give you two of those and ask for the third. For example, "A cycle receives 500 kJ heat and rejects 200 kJ heat (net $Q_{\text{in}} = 300$ kJ). How much net work is produced?" Answer: 300 kJ, since net W_{out} must equal net Q_{in} if $\Delta U = 0$ over a cycle.

Finally, keep in mind the first law doesn't tell you **how** the energy is transferred (fast or slow, at what temperature, etc.), only the balance. It's a conservation principle. No matter the process path, as long as you start and end at the same states and count heat/work properly, $Q - W$ will equal ΔU. This makes it powerful: you can solve problems without knowing every detail of the process, as long as you know initial/final states and the energy interactions. Be sure to stick to the sign convention and include all relevant energy terms, and you'll reliably account for energy in closed systems.

K11.T02.S02 – Steady-Flow Energy Equation (Open System)

Principle:

- Many engineering devices involve fluid flow – mass enters or exits a control volume. The steady-flow energy equation is the first law of thermodynamics written for a steady-state open system (a control volume).

- "Steady state" means conditions inside the control volume don't change with time (no accumulation of energy within the system: what comes in eventually goes out). This is a valid approximation for turbines, compressors, nozzles, heat exchangers, pumps, etc., running under constant conditions.

- In an open system, fluid carries energy in and out. Besides heat and work, **enthalpy (h)** becomes key because it accounts for

internal energy *plus* flow work ($P\,v$) needed to push mass into or out of the control volume.

- The energy per unit mass of fluid also includes **kinetic energy** ($V^2/2$) and **potential energy** ($g\,z$) terms. The steady-flow equation tracks changes in these as fluid moves from inlet to outlet.

- Essentially, the equation balances all forms of energy for flow: the energy carried in by mass flow plus any heat input equals the energy carried out by mass flow plus any work output (shaft work), accounting for changes in h, V, and z between inlet and exit.

Steady-Flow Energy Equation – *Conservation of energy for a control volume with mass flow at steady state.*

$$\dot{m}\left(\Delta h + \frac{\Delta V^2}{2} + g\,\Delta z\right) = \dot{Q} - \dot{W}$$

- $\dot{m}$**:** Mass flow rate through the system (kg/s). For one-inlet, one-outlet steady flow, $\dot{m}_{\text{in}} = \dot{m}_{\text{out}} = \dot{m}$ (the mass flow is constant through the device). If multiple streams exist, you'd apply this term for each stream appropriately.
- Δh**:** Change in specific enthalpy of the fluid, $h_{\text{out}} - h_{\text{in}}$ (J/kg). Enthalpy $h = u + P\,v$ represents the total energy per unit mass associated with fluid (the internal energy *plus* the energy required to make room for that fluid in flow). A positive Δh means the fluid's enthalpy increased (e.g. it was heated or compressed); a negative Δh means enthalpy decreased (e.g. it cooled or expanded).
- $\frac{\Delta V^2}{2}$**:** Change in kinetic energy per unit mass, $\frac{V_{\text{out}}^2 - V_{\text{in}}^2}{2}$ (J/kg). Accounts for fluid velocity changes (important in devices like nozzles, where flow speeds up, or diffusers, where flow slows down).
- $g\,\Delta z$**:** Change in potential energy per unit mass due to height difference, $g(z_{\text{out}} - z_{\text{in}})$ (J/kg). Accounts for gravitational energy if the inlet and outlet are at different elevations (e.g. in a pump lifting water, or a turbine dropping water down). g is the acceleration due to gravity (9.81 m/s² in SI, 32.17 ft/s² in US units).
- $\dot{Q}$**:** Heat transfer rate *into* the control volume (J/s or W). Positive if the device is heated by an external source. If the device rejects heat (like a radiator or some condensers), $\dot{Q}$ would be negative (net heat leaving).
- $\dot{W}$**:** Work rate *done by* the control volume (J/s or W). Often called $\dot{W}_{\text{out}}$ or $\dot{W}_{\text{shaft}}$ for devices like turbines (power output). Positive if work is *leaving* the system (output). For devices that consume work (pumps, compressors), this term would come out negative in the equation as written (because work is going *into* the system, not produced by it).

Assumptions: This form assumes **steady flow** – none of the properties inside the control volume are changing with time. (In other words, after the system has been running a while, for every unit of mass that enters with some energy, another unit leaves with energy so the total inside stays constant.) We also assume a single inlet and single outlet for simplicity (the equation can be extended to multiple inlets/outlets by summing over each). Properties like h, V, z are taken at the inlet and exit sections (assuming uniform flow at those sections). If multiple forms of work exist, $\dot{W}$ represents the net work output (shaft work out minus any work in, etc.). Importantly, **steady flow** implies any energy that enters by heat or mass flow is exactly balanced by energy leaving via work or mass flow, with no net accumulation in the system.

Special cases (common device assumptions): Depending on the device, certain terms drop out, giving simpler forms:

- **No heat, no work (adiabatic & no shaft work):** If $\dot{Q} = 0$ and $\dot{W} = 0$, the equation reduces to $\dot{m}\left(\Delta h + \Delta\frac{V^2}{2} + g\Delta z\right) = 0$. For a single flow stream, this implies $h_{\text{in}} + \frac{V_{\text{in}}^2}{2} + g z_{\text{in}} = h_{\text{out}} + \frac{V_{\text{out}}^2}{2} + g z_{\text{out}}$. This is essentially an energy conversion statement (often, one form of energy converts to another). For instance, in a nozzle (horizontal, adiabatic, no work), $h_{\text{in}} + V_{\text{in}}^2/2 = h_{\text{out}} + V_{\text{out}}^2/2$ – enthalpy drop equals kinetic energy gain. For an (ideal) hydropower pipe with no losses, $g z_{\text{in}} = \frac{V_{\text{out}}^2}{2}$ (potential turns into kinetic). This is analogous to Bernoulli's equation when flow is incompressible.

- **Negligible kinetic and potential changes:** If $\Delta V^2/2 \approx 0$ and $g\Delta z \approx 0$ (common in devices where flow speeds and elevation difference are small), the equation simplifies to $\dot{m}\,\Delta h = \dot{Q} - \dot{W}$. Many steady-flow devices use this: e.g. a steam **boiler** (no work, so $\dot{Q} = \dot{m}\Delta h$; the heat input increases fluid enthalpy), or an **adiabatic pump** (no heat, so $-\dot{W} = \dot{m}\Delta h$; work input raises fluid enthalpy).

- **Multiple inlets/outlets:** In a mixing chamber or a junction, you'd write $\sum\dot{m}_{\text{in}}\left(h + \frac{V^2}{2} + gz\right) = \sum\dot{m}_{\text{out}}\left(h + \frac{V^2}{2} + gz\right) + \dot{W} - \dot{Q}$ (taking all outflows to one side). But the FE exam usually sticks to single-inlet, single-outlet, or clearly indicates how to handle each stream (often mass conservation plus an energy balance separately).

Use vs. other forms: Use the steady-flow energy equation for any **open-system problem at steady state** – typical examples: turbines (find work output given inlet/outlet steam conditions and heat loss), compressors (find required work input given pressure rise and cooling water removal), nozzles (find exit velocity given pressure drop and assuming adiabatic), pumps (find power needed to lift water a certain height and pressure), and heat exchangers (relating heat transfer to enthalpy change of fluids). It is effectively the open-system equivalent of $Q - W = \Delta U$, but now ΔU is replaced by $\dot{m}\Delta h$ (plus KE/PE terms) since mass flow brings in/out energy. For a **closed (non-flow) process**, revert to the previous subtopic's equation. For **unsteady flow** situations (transient operation), the steady assumption breaks and you must include time-dependent terms or accumulation (covered in the next subtopic).

Common pitfalls:

- **Unit inconsistency:** Make sure all terms are in the same unit system. A very common error is forgetting to convert velocity terms to energy units consistent with enthalpy. For example, if enthalpy h is given in kJ/kg, and you have a velocity in m/s, note that $1\ \text{m}^2/\text{s}^2 = 1$ J/kg, so you should convert $\frac{V^2}{2}$ to kJ/kg by dividing by 1000. Similarly, in US units, if enthalpy is in BTU/lbm and velocity in ft/s, you must divide $V^2/2$ by the conversion factor ($g_c = 32.174$ lbm·ft/(lbf·s^2) and also by 778 ft·lbf per BTU if mixing those units). It can be easier to convert everything to SI units to avoid these pitfalls, but be prepared either way.

- **Sign convention for work:** In this formula, $\dot{W}$ is taken as work *produced* by the system (like a turbine's output). For devices that consume power (pump, compressor), the $\dot{W}$ will come out negative if you plug in Δh positive (since enthalpy increases when you add work to fluid). An alternative approach some use is to move $\dot{W}$ to the left: $\dot{W} + \dot{m}(\Delta h + \Delta KE + \Delta PE) = \dot{Q}$, and then treat $\dot{W}$ as positive for input work. Either way works as long as you're consistent. A quick check: if you forget the sign convention, you might end up with a negative value for a quantity that should be

positive (like getting a negative "power" for a pump when you know it requires positive power input). Always interpret your result: a negative $\dot{W}$ in the original equation simply means work is going into the system.

- **Ignoring significant terms:** Most exam problems hint at which terms are negligible, but don't assume, for example, that kinetic energy is zero if the fluid changes velocity significantly (like through a nozzle or if there's a big pipe diameter change). Likewise, don't drop $g\Delta z$ if there's a notable height difference (e.g. pumping water up a building or a hydro turbine scenario). Include all terms unless you can justify otherwise from the problem statement.

- **Mixing up h and u:** Remember $h = u + Pv$. In flow problems, use enthalpy for energy carried by fluid streams because it automatically accounts for the $P\,v$ work needed to push the fluid in/out. If a problem gives you internal energy values or asks something with u, you likely have a closed system scenario. If you erroneously use u in place of h in an open system energy balance, you'll be missing the flow work term and get the wrong answer. Similarly, if using steam tables, be sure to use the enthalpy values for inlet/outlet (unless a trick in the problem explicitly calls for internal energy, which would be unusual in steady-flow contexts).

Exam Handbook Search Cues (Not affiliated with or endorsed by NCEES): *steady flow energy, open system first law, control volume, enthalpy (h), kinetic energy ($V^2/2$), potential (gz)*

Explanation & Analysis: The steady-flow energy equation is your tool for analyzing devices where fluid is moving through. To use it in practice on an exam problem:

1. **Define the control volume:** Draw a boundary around the device of interest (turbine, nozzle, pump, heat exchanger, etc.). Identify the inlet and outlet ports where mass crosses. This helps visualize what's in your energy balance. Label states 1 (inlet) and 2 (outlet), for instance, and note known properties (pressures, temperatures, etc.) at those states.
2. **Identify energy transfers:** Determine if there's heat transfer ($\dot{Q}$) across the boundary (e.g. a steam generator has heat input, a condenser has heat output, a well-insulated component might have $\dot{Q} \approx 0$). Determine if there's shaft work ($\dot{W}$) crossing the boundary (turbine or engine output, compressor or pump input). Apply the sign convention: heat *into* the system is positive Q, work *out of* the system is positive W. If you assume $\dot{W}$ as output, then for a pump or compressor you'll end up with a negative $\dot{W}$ (indicating work input). It's fine to get a negative result as long as you interpret it correctly.
3. **Simplify the equation for the device:** Start from $\dot{m}\left(\Delta h + \Delta\frac{V^2}{2} + g\Delta z\right) = \dot{Q} - \dot{W}$. Cancel any terms that are negligible based on the problem description. For example:

   Nozzle/Diffuser: likely $\dot{Q} \approx 0$, $\dot{W} = 0$, and $\Delta z = 0$, so you get $h_1 + V_1^2/2 = h_2 + V_2^2/2$.

   Throttle (valve): $\dot{Q} \approx 0$, $\dot{W} = 0$, and usually $\Delta KE \approx 0$, $\Delta PE = 0$, so $h_1 = h_2$.

   Pump/Compressor (adiabatic): $\dot{Q} = 0$, $\Delta KE \approx 0$, ΔPE might be given or small, so $\dot{m}\Delta h = -\dot{W}$ (work in).

   Heat exchanger (no work): $\dot{W} = 0$, maybe no KE/PE changes, so $\dot{m}\Delta h_{\text{hot}} + \dot{m}\Delta h_{\text{cold}} = 0$ if well insulated (heat lost by one fluid = heat gained by the other).

   By simplifying first, you reduce error chances and calculation effort. Keep track of units now – if you drop terms, make sure the units of the remaining terms match (they should, since every term in the full equation was energy per time).

4. **Solve for the desired quantity:** After simplification, you'll typically have one equation relating input/output energies. Solve for the unknown. It could be a heat transfer rate, a work (power) value, an exit velocity, an exit temperature, etc. Use thermodynamic property relations where needed: - If enthalpies are needed, you might use steam tables or $h = c_pT$ for ideal gases (if phase change or high accuracy isn't involved). - If a velocity is needed, isolate the $V^2/2$ term and take square roots (careful with unit conversion: e.g. if h is in kJ/kg, convert it to J/kg before equating to $V^2/2$ in m²/s²). - For a pump, if you don't have enthalpy data, use $\Delta h \approx v\Delta P$ for liquids (with v specific volume) or find data for water enthalpy change (which is small per kg for moderate pressure increases).

Let's illustrate a couple of exam-relevant scenarios:

Turbine example: Steam enters a turbine at 3 MPa, 400°C and exits at 0.1 MPa, 90% quality. It's adiabatic. Find the work output per kg of steam. Here, $\dot{Q} = 0$, and neglect kinetic and potential changes unless specified (often turbine inlet velocity is moderate, but assume small compared to enthalpy change). The energy equation reduces to $0 = \Delta h - \dot{W}/\dot{m}$, or $\dot{W}/\dot{m} = h_{\text{in}} - h_{\text{out}}$. Using steam tables, find h_{in} (superheated steam) and h_{out} (wet steam at 0.1 MPa, x=0.9). Then $w_{\text{out}} = h_{\text{in}} - h_{\text{out}}$ in kJ/kg. That gives work per kg. If they want power, multiply by mass flow. A quick check: h_{in} might be around 3200 kJ/kg, h_{out} around maybe 2400 kJ/kg (just estimating), so work output ~800 kJ/kg. If you got a negative number, you'd know you mixed up in/out or sign.

Pump example: Water at 20°C, 1 bar is pumped to 50 bar adiabatically at 0.01 m³/s. Find the required power (ideal). Since water is liquid, use $w_{\text{in}} = v\Delta P$. At 20°C, specific volume $v \approx 0.001\ \text{m}^3/\text{kg}$. $\Delta P = 49\ \text{bar} = 4.9 \times 10^6$ Pa. So $w_{\text{in}} = 0.001 \times 4.9 \times 10^6 = 4900$ J/kg $= 4.9$ kJ/kg. That's the enthalpy rise per kg. For flow rate 0.01 m³/s, the mass flow $\dot{m} = \frac{0.01\ \text{m}^3/s}{0.001\ \text{m}^3/\text{kg}} =$ 10 kg/s. Multiply: power $\dot{W}_{\text{in}} = 4.9$ kJ/kg $\times$ 10 kg/s $= 49$ kJ/s $=$ 49 kW. That's ideal. If the problem said the pump is 70% efficient, you'd then do actual power = 49/0.7 ≈ 70 kW required. Note we assumed no ΔKE or Δz (if the pump also lifted water 10 m, we'd add $g\Delta z = 9.81 * 10 \approx 98 J/kg$, minor compared to 4900 J/kg from pressure).

Nozzle example: Air at 600 kPa, 300°C enters a nozzle and expands to 100 kPa. Assume isentropic (i.e., adiabatic and reversible) expansion. If inlet velocity is low, find exit velocity. Here, h_{in} and h_{out} can be found via isentropic ideal gas relations or tables. For an ideal gas, isentropic means T_{out} can be found from $P_{\text{out}}/P_{\text{in}}$ and γ (or use $h(T)$ values). Once you have h_{in} and h_{out}, apply $h_{\text{in}} + V_{\text{in}}^2/2 = h_{\text{out}} + V_{\text{out}}^2/2$. If V_{in} is negligible, $V_{\text{out}} = \sqrt{2(h_{\text{in}} - h_{\text{out}})}$. Just be sure h values are in J/kg when doing this. This gives exit velocity in m/s. If you see a supersonic value, that's fine for high-pressure drops. But if you get an imaginary number under the root (negative argument), that means something's wrong (likely swapped in/out or sign errors).

Each term in the steady-flow equation has a clear physical meaning: $\dot{m}h$ is the energy flow due to enthalpy of fluid (including flow work), $\dot{m}\frac{V^2}{2}$ is the power associated with bulk kinetic energy, $\dot{m}gz$ is the power associated with lifting the fluid, $\dot{Q}$ is heat power in, and $\dot{W}$ is mechanical power out. The equation simply says: *the sum of energies coming in (by mass flow and heat) equals the sum going out (by mass flow and work)*, for a steady state with no accumulation. This powerful statement, when pared down to the specifics of a device, makes solving open-system problems systematic. By practicing identifying which terms matter for which device, you'll speed through many thermodynamics questions on the FE exam with confidence.

K11.T02.S03 – Special Steady-Flow Devices (Nozzles, Throttles, Pumps/Fans)

Principle:

In many steady-flow devices, the general energy equation simplifies drastically due to specific operational assumptions. Recognizing these **special cases** can save time on the FE exam:

- **Nozzles and diffusers:** focus on converting energy between pressure/enthalpy and kinetic energy. Typically, nozzles accelerate flow (pressure drops, velocity rises), while diffusers decelerate flow (pressure rises, velocity falls). They are usually treated as adiabatic with no work transfer.

- **Throttling valves:** cause a significant pressure drop by irreversibly restricting flow (like a valve, orifice, or porous plug). They have no shaft work and typically no heat exchange during the short restriction. The key ideal assumption is that the process is **isenthalpic** (enthalpy in = enthalpy out) for an ideal throttle.

- **Pumps, Fans, and Compressors:** add energy to a fluid via work input (shaft work in). In analysis, they are often assumed adiabatic (no heat loss) and with negligible kinetic or potential energy change between inlet and outlet. The work input primarily increases the fluid's enthalpy (and thus usually its pressure). Pumps generally refer to liquids (incompressible flow), fans to moving gases with relatively small pressure rise, and compressors to gases with significant pressure increase – but thermodynamically, the energy bookkeeping is similar. - Being aware of these cases helps you quickly write the reduced form of the energy equation without carrying terms that go to zero. Below is a summary of the ideal energy relations for each of these devices under typical FE exam assumptions:

Nozzles and Diffusers: *Adiabatic, no shaft work, usually no change in height.* These devices trade enthalpy and kinetic energy. For a nozzle (flow speeds up), enthalpy drops and kinetic energy increases. For a diffuser (flow slows), enthalpy rises and kinetic energy decreases. The steady-flow energy balance per unit mass simplifies to:
$h_{\text{in}} + \frac{V_{\text{in}}^2}{2} = h_{\text{out}} + \frac{V_{\text{out}}^2}{2}$. This equation means any drop in enthalpy appears as an increase in $V^2/2$ (nozzle) or vice versa for a diffuser. Often, inlet velocity in a nozzle is much lower than outlet, so sometimes V_{in} is assumed negligible if the problem allows. But be careful: if a question gives both velocities, use them. The absence of Q and W is what makes this clean: it's basically conversion of internal/pressure energy to kinetic form or vice versa. A practical tip: if asked for a nozzle exit velocity, find the enthalpy drop (using initial and final pressures and assuming isentropic flow to get h_{out}), then apply $V_{\text{out}} = \sqrt{2(h_{\text{in}} - h_{\text{out}}) + V_{\text{in}}^2}$. Always check units as mentioned before.

Throttling Valve (Isenthalpic): *No work, no heat, negligible ΔKE and ΔPE.* A throttling device (like a partially closed valve or expansion valve in refrigeration) causes fluid pressure to drop *drastically* at essentially constant enthalpy (ideal assumption). The simplified relation is:

$h_{\text{in}} = h_{\text{out}}$. In other words, enthalpy doesn't change through the throttle. This is a key property: for an ideal gas, that means temperature stays the same across an ideal throttle (since $h = h(T)$ for ideal gases). For real gases, throttling usually causes cooling (the Joule–Thomson effect), but on the FE exam you'll likely apply $h_i = h_e$ using provided property data (like refrigerant tables) to find, say, the outlet temperature after a valve given the inlet state and outlet pressure. Essentially, the enthalpy that enters is "used up" in irreversibly generating internal energy and a little bit of kinetic turbulence, but you don't account for those separately – the total h stays the same. Remember, because it's isenthalpic, if the fluid is ideal gas and thus stays at same enthalpy, it stays at same temperature; if it's a refrigerant, you expect a drop in temperature often, because for real fluids enthalpy constancy doesn't mean T constant. The throttle is highly irreversible, but we love it in analysis because it's simple: just set enthalpies equal.

Pumps, Fans, Compressors: *Work input, usually adiabatic, negligible ΔKE and ΔPE.* These devices use shaft work to increase the fluid's enthalpy (and pressure). The steady-flow energy relation per unit mass (taking work input w_{in} as positive into the fluid) is: $h_{\text{out}} = h_{\text{in}} + w_{\text{in}}$. Equivalently, $w_{\text{in}} = h_{\text{out}} - h_{\text{in}}$ is the work (energy) added to each kilogram of fluid. If you are given or can calculate h_{out} and h_{in} (from pressures and temperatures, using either tables or formulas), you can find the required work input. For liquids, sometimes you'll use $w_{\text{in}} \approx v\,\Delta P$ (with v the specific volume, assumed roughly constant) to estimate the work per unit mass without full thermodynamic tables. Fans often impart some kinetic energy to the fluid as well (air leaves a fan with higher velocity), but if not significant, we focus on enthalpy rise which for an ideal gas corresponds to temperature rise. On the exam, a common task is to calculate pump power: you'd multiply w_{in} (in J/kg or ft·lbf/lbm) by the mass flow rate to get $\dot{W}_{\text{in}}$. If efficiency is given, adjust accordingly (more on that shortly).

In summary: - **Nozzles/Diffusers:** set $Q = 0, W = 0, \Delta z = 0$ and use $h_{\text{in}} + V_{\text{in}}^2/2 = h_{\text{out}} + V_{\text{out}}^2/2$. One form of energy goes into another.

- **Throttles:** set $Q = 0, W = 0, \Delta KE = 0, \Delta PE = 0$, giving $h_{\text{in}} = h_{\text{out}}$. Enthalpy constant.

- **Pumps/Compressors (ideal adiabatic):** set $Q = 0, \Delta KE \approx 0, \Delta PE \approx 0$, so $-W_{\text{in}} = \dot{m}\Delta h$ or per unit mass $w_{\text{in}} = \Delta h$. Work in equals enthalpy rise. (If you prefer to think in terms of output from the fluid's perspective, $\dot{W}_{\text{out}}$ is negative here, which is fine – just ensure clarity in sign usage.)

These are just special applications of the steady-flow equation and make solving exam problems quicker once you identify the device type.

Footnotes and variations:

- **Diffusers** do the exact opposite of nozzles: h rises, V drops. Same equation applies. The term "nozzle" usually implies we care about the exit velocity, whereas "diffuser" implies we care about pressure recovery. But analysis-wise, treat it symmetrically.

- **Real devices & efficiency:** In reality, devices are not ideal. For example, a nozzle will have some losses (not all enthalpy drop

becomes kinetic energy, so actual exit velocity is lower – we define a nozzle efficiency to account for that). A **turbine** (similar to a reverse pump: work output, usually adiabatic) isn't in the list above explicitly, but it follows $w_{\text{out}} = h_{\text{in}} - h_{\text{out}}$ for ideal adiabatic turbine. If not ideal, **isentropic efficiency** is used: $\eta_{\text{turbine}} = \frac{\text{actual work output}}{\text{ideal work output}} = \frac{h_{\text{in}} - h_{\text{out, actual}}}{h_{\text{in}} - h_{\text{out, isentropic}}}$. Similarly for pumps/compressors: $\eta_{\text{pump}} = \frac{\text{ideal work (min)}}{\text{actual work}} = \frac{h_{\text{out, ideal}} - h_{\text{in}}}{h_{\text{out, actual}} - h_{\text{in}}}$. The FE Exam might include such efficiency calculations in a turbomachinery context. If given efficiency, remember to use it to find actual enthalpy change or required work.

- **Joule–Thomson effect:** As a note, throttling (constant enthalpy) can cause cooling or heating depending on the fluid's Joule–Thomson coefficient. Most gases at typical conditions cool upon throttling (e.g. refrigerants, steam above saturation). Ideal gases have JT coefficient zero (no temperature change). This is advanced, but just recall: if they ask qualitatively, a refrigerant or real gas usually comes out colder after a throttle.

Common mistakes in these special cases:

- **Nozzle/Diffuser:** Forgetting to convert units when computing $V^2/2$ or neglecting a given inlet velocity. If the problem provides an inlet velocity, it's probably significant enough to include. Also, if using an energy equation approach, ensure you use enthalpy values appropriate for the states. If you assume isentropic and you have initial P,T, find final enthalpy at P_{out} *assuming* entropy constant (either via tables or isentropic exponent formulas). A mistake would be to use initial enthalpy for outlet or something like that.

- **Throttle:** Thinking temperature stays constant for any throttling process. Repeat: only true for ideal gases (where $h(T)$). If given a real substance, don't assume $T_{\text{out}} = T_{\text{in}}$ unless the problem explicitly hints at it. Instead, use $h_{\text{out}} = h_{\text{in}}$ and consult property data for T_{out}. Another mistake is trying to apply formulas like $Pv^{\gamma} =$ const or energy equations that aren't valid for a throttle (because throttle is highly irreversible, not isentropic). Just stick to $h_{\text{in}} = h_{\text{out}}$.

- **Pump/Compressor:** Confusion about work sign and mixing up where to plug efficiency. If you use the steady flow equation with $\dot{W}$ as work *out*, you might write $-\dot{W}_{\text{pump}} = \dot{m}(h_{\text{out}} - h_{\text{in}})$ to solve ideal work input (the negative reminds you it's input). Or simply $W_{\text{required}} = \dot{m}(h_{\text{out}} - h_{\text{in}})$ as a positive number. Know that this is ideal (isentropic) if you used isentropic relations or incompressible formula. To get actual, divide by η (for pump/compressor). It's easy to accidentally multiply instead of divide or vice versa – remember, an inefficient pump needs *more* work than ideal, so actual work = ideal work / η (since $\eta =$ ideal/actual for work-input devices). For a turbine, an inefficient one produces *less* work than ideal, so actual work = ideal work * η (since $\eta =$ actual/ideal for work-output devices). Keep these straight.

Exam Handbook Search Cues (Not affiliated with or endorsed by NCEES): *nozzle, diffuser, throttling (isenthalpic), pump work, compressor, enthalpy drop, enthalpy rise*

Explanation & Analysis: When approaching an FE problem, first identify if it's one of these common devices, because you can then recall these simplified relationships instead of deriving from scratch: - If you see a **nozzle or diffuser** problem (e.g., "Steam enters a nozzle at X pressure and temperature, exits at Y pressure, find the exit velocity…" or "Air slows down in a diffuser, find the pressure rise…"), immediately think: no shaft work, likely adiabatic. So apply $h_1 + \frac{V_1^2}{2} = h_2 + \frac{V_2^2}{2}$. Often you may assume $V_1 \approx 0$ if it's from a large reservoir, but if values are given use them. Solve for the unknown velocity or enthalpy. For instance, to find exit velocity: $V_2 = \sqrt{2(h_1 - h_2) + V_1^2}$. To find pressure rise in a diffuser, you might need isentropic relations or tables to relate that velocity drop to enthalpy increase and thus to pressure increase.

- In a **throttle** (look for keywords: "valve," "throttling process," "expansion valve," "porous plug"), you know enthalpy stays the same. So if you have upstream conditions (say, a refrigerant at high pressure, saturated liquid) and downstream pressure, you set $h_{\text{down}} = h_{\text{up}}$. Then use the refrigerant property data at the new pressure to find what state has that same enthalpy (which might be a mixture quality or a temperature). A typical exam scenario: a refrigerant at 1 MPa, saturated liquid (h known from table) throttles to 0.2 MPa. What is the quality at exit? You'd take h_{in} (sat. liquid at 1 MPa), set equal to h_{out} at 0.2 MPa, and since at 0.2 MPa that enthalpy lies between sat. liquid and sat. vapor values, compute quality $x = \frac{h - h_f}{h_{fg}}$. That's your answer. This is classic in refrigeration cycle questions. If ideal gas (like air through a valve, rarely asked because trivial), you'd just say temperature doesn't change (assuming ideal gas behavior, since $h(T)$ only).

- For a **pump or compressor question**, identify it as a work-consuming device. If it says "ideal" or "reversible adiabatic", use $w_{\text{in}} = \Delta h$ (or $v\Delta P$ for liquids). If they give an efficiency, do the ideal calc first, then divide by efficiency to get actual work input (for pump/compressor). For example, "Calculate the motor power required to pump 50 gpm of water up 100 ft and from 20 psia to 50 psia. Pump efficiency 80%." You'd do: elevation work per lbm = $g\Delta z = 32.17 \times 100 = 3217\ \text{ft}^2/\text{s}^2$ (divide by 32.17 to get ft·lbf/lbm, that actually gives 100 ft·lbf/lbm directly, since g cancels – easier: 100 ft of head = 100 ft·lbf per lbm). Pressure work per lbm = $\Delta P/\rho$. In US units, $\Delta P = 30$ psi $= 30 \times 144$ psf, ρ of water ~62.4 lbm/ft³, so specific volume $v = 1/62.4$ ft³/lbm. So flow work per lbm = $v\Delta P = \frac{1}{62.4} \times (30 \times 144) \approx 69.3$ ft·lbf/lbm. Total ideal work ~169.3 ft·lbf/lbm (100 from lift + 69.3 from pressure). Mass flow: 50 gpm is 50/7.48 ≈ 6.68 ft³/min, which is 0.111 ft³/s. At 1/62.4 ft³/lbm, that's 0.111 × 62.4 = 6.93 lbm/s. So ideal power = $169.3\ \frac{\text{ft·lbf}}{\text{lbm}} \times 6.93\ \frac{\text{lbm}}{\text{s}} = 1173$ ft·lbf/s. 1 hp is 550 ft·lbf/s, so that's 2.13 hp ideal. With 80% eff, actual ≈ 2.13/0.8 = 2.66 hp. We'd give answer ~2.7 horsepower. Notice we combined elevation and pressure changes as separate energy contributions – this is equivalent to using enthalpy difference if we had those values. Always double-check if the problem expects an answer in kW, hp, etc., and convert accordingly.

- **Regarding fans**, they often mention increase in kinetic energy of air. If a fan delivers air at some velocity, technically the kinetic energy added is $\frac{V^2}{2}$ per unit mass, which is part of the work input. But fans are usually low pressure rise devices; exam problems might not dive deep into fan specifics beyond maybe stating that the motor power mostly goes into kinetic energy of airflow (and a small pressure rise). So you could get a question: "A fan blows 2 kg/s of air at 20 m/s. What minimum power is needed just to give the air its kinetic energy?" Answer: $\dot{W} = \dot{m}\frac{V^2}{2} = 2 * (20^2/2) = 2 * 200 = 400 J/s = 400 W$." Simple application of KE term.

Recognizing these archetypes means less time writing general equations and more time plugging in numbers correctly. It also reduces errors, because you're less likely to omit a term or mis-assign a sign if you know, for example, "throttle = no work, no

heat, so just h in = h out." In complex systems (like a power plant cycle), you apply these devicewise: turbine (use turbine relation), pump (pump relation), boiler (heat addition = enthalpy increase), condenser (heat removal = enthalpy drop), etc. Each piece is steady state but with its own simplified formula.

Always validate your result with intuition:

- In a **nozzle**, did the pressure drop result in a reasonable velocity? (E.g., pressure drop from high to low should yield high speed, hundreds of m/s maybe for gases, tens for liquids due to density differences.) - In a **throttle**, if a high-pressure liquid goes through, the outlet should partially flash (some liquid becomes vapor) typically – does your quality calculation reflect that? If you got quality > 1 or < 0, something's off.

- For a **pump/compressor**, if you calculate an absurdly high power for a modest task, re-check unit conversions or efficiency usage. On the flip side, if you get a tiny power for a big job (like pumping many gallons per minute up a tall height), likely an error.

By mastering these special cases, you effectively have a shortcut for many of the most common thermodynamics problems, allowing you to allocate time to other problems on the exam. They are the "pattern recognition" part of thermo: the problem might not explicitly say "this is a nozzle," but if you spot it, you know exactly which formula to apply. Practice identifying these by keywords and you'll streamline your problem-solving significantly.

K11.T02.S04 – Transient Energy Analysis Basics (Unsteady Systems)

Principle:

- Not all systems run at steady state; some processes involve **transient (unsteady) changes** where conditions inside the system change over time. In such cases, energy can **accumulate** or **deplete** within the control volume.

- A classic example is filling or discharging a vessel: as mass flows in or out, the internal energy of what's inside can increase or decrease with time. Another example is a heating or cooling process in a closed system, where temperature and internal energy are changing over time.

- The first law of thermodynamics in its general form includes a term for the **rate of change of energy stored in the system**. During a transient process, that storage term does not vanish (unlike steady state where it's zero).

- While the FE exam emphasizes steady-state analysis, you should grasp the basic approach for unsteady energy problems: apply conservation of energy with a time-dependent (or cumulative) term, often simplifying by considering initial and final states for a process rather than solving differential equations.

- These problems often boil down to accounting for the total energy change in the system over the process duration and relating it to the net heat and work exchange, plus any energy carried by mass flows.

Definition: *Transient energy analysis* refers to applying the first law of thermodynamics to situations where the system's state is changing with time (unsteady conditions). It means tracking how energy accumulates in or is depleted from the system in addition to accounting for heat and work transfers. In equation form, it introduces a term for dE_{system}/dt (rate of change of energy inside the system).

Where it matters (exam impact): Transient analysis might appear in questions about **charging or discharging tanks**, **heating or cooling of a system over time**, or **processes with significant start and end differences**. For example, you might see: "A rigid insulated tank is initially evacuated. It is connected to a high-pressure air line and filled until the pressure inside reaches some value. Find the final temperature in the tank." Here, mass and energy flow into the system over time (transiently), and you'd use an energy balance *from initial to final state*. Another example: "A piston-cylinder with no leaks is fitted with a cooling coil. Initially the gas is at state A, then it is cooled to state B. How much heat was removed?" That's transient (initial → final) in a closed system: you'd do $Q - W = \Delta U$ over that process (work can be found from mechanics if needed, etc.). The exam usually simplifies transients by giving enough info to do an overall balance between states, rather than requiring solving a time-dependent differential equation. Essentially, **think in terms of energy accounting between the start and end of a process**.

Pitfall or confusion point: The biggest mistake in unsteady problems is to apply a steady-state formula to a situation that isn't steady. For instance, trying to use $\dot{m}(\Delta h) = \dot{Q} - \dot{W}$ directly when the mass in the system is changing can be incorrect, because Δh in steady formula assumes the same mass just flowing through, not accumulating. In transient scenarios, **the mass within the system can change**, so you must account for that in energy storage. Another common confusion is choosing the control volume correctly: sometimes you might include a portion of the surroundings in the "system" to make it easier (like including a piston's potential energy in a system). Be clear on what you consider the system and stick with it when accounting for energy. Also, sign conventions still matter: if the system's energy increases, something on the right side of your energy equation should be positive net in, etc.

Micro-check: True or False? – *When a rigid tank is being filled with fluid (with no heat loss and no external work), the increase in the internal energy of the tank's contents equals the enthalpy of the fluid that entered.*

Answer: True. All energy that enters the control volume comes in with the fluid (as enthalpy flow). In an adiabatic filling of a rigid tank, no work is done by the tank (rigid means volume is constant, so the only "work" is flow work which is accounted in enthalpy), and no heat is lost. Thus, the enthalpy carried in by the mass flow ends up as increased internal energy of the fluid in the tank. This is a classic result used in filling process calculations.

Exam Handbook Search Cues (Not affiliated with or endorsed by NCEES): *unsteady, transient first law, energy accumulation, filling process,* dE/dt

Explanation & Analysis: In a transient energy problem, think of the first law in its most general form:

$$\frac{dE_{\text{system}}}{dt} = \dot{Q}_{\text{in}} - \dot{W}_{\text{out}} + \sum_{\text{inlets}} \dot{m}_{\text{in}} \left(h + \frac{V^2}{2} + gz \right) - \sum_{\text{exits}} \dot{m}_{\text{out}} \left(h + \frac{V^2}{2} + gz \right)$$

This looks intimidating, but each term is familiar: dE_{system}/dt is the rate of change of energy inside the control volume (internal + kinetic + potential). The summation terms account for energy carried in or out by mass flow (similar to the steady-flow terms, but now in general there can be an imbalance, causing storage change). For the FE exam, you rarely if ever have to use this full differential

form. Instead, the typical approach is to integrate it over the duration of the process (from start to finish). Doing that gives:

$$E_{\text{final}} - E_{\text{initial}} = Q_{\text{in}} - W_{\text{out}} + \sum_{\text{mass in}} m_{\text{in}}\left(h + \frac{V^2}{2} + gz\right) - \sum_{\text{mass out}} m_{\text{out}}\left(h + \frac{V^2}{2} + gz\right)$$

This is an **overall energy balance** from initial state to final state. It says: the change in energy stored in a system equals the net heat added minus the net work done by the system, plus the energy carried in by incoming mass flows, minus the energy carried out by outgoing mass flows.

To solve a transient problem on the exam, follow these steps:

5. **Define the system (control volume) and identify initial and final states:** For example, consider a rigid tank that is being filled with air from a supply line. Your system could be the tank contents. Initial state: empty tank (or maybe filled with some initial condition). Final state: tank at some pressure, temperature after filling. Because the system is the tank, mass crosses the boundary (air enters). The initial energy E_{initial} might be zero (if vacuum) or some U_i if initially had something. The final energy E_{final} is the internal energy of the final mass of air in the tank (since rigid, no KE/PE of bulk).
6. **Apply mass conservation if needed:** Often, you need to know how much mass came in or left. In the filling example, initial mass $m_i = 0$, final mass m_f can be found from ideal gas law using final P, V, T (once you find T, or sometimes you assume final T or find it from energy). Or they might directly give the mass that entered ("X kg of air is added"). Similarly, for a discharging, you figure out mass out from pressure drop, etc.
7. **Write the energy balance for the whole process:** Using the integrated form above. For the rigid, adiabatic tank filling with no work: $Q_{\text{in}} = 0$ (insulated tank), $W_{\text{out}} = 0$ (rigid tank means volume didn't change, so no boundary work; also no shaft, etc.), one inlet with $m_{\text{in}} = m_f$ (mass that ends up in tank), carrying an enthalpy h_{in} (this h would be evaluated at the supply line conditions, since that's the state at which the fluid enters), no exits. So the balance simplifies to $U_{\text{final}} - U_{\text{initial}} = m_{\text{in}}\, h_{\text{in}}$. If initially empty, $U_i = 0$. Thus $U_f = m_f h_{\text{in}}$. Per unit mass inside, $u_f = h_{\text{in}}$. This tells us the final specific internal energy equals the specific enthalpy of the incoming fluid. Since for an ideal gas $h(T)$ and $u(T)$ are functions of temperature, if h_{in} was at supply line temperature, it means the final temperature in the tank equals the supply temperature (for ideal gas in this scenario). If the supply was at the same temperature but just higher pressure, nothing changes in T (this is effectively a filling process that is isothermal for ideal gas if no heat loss – somewhat unintuitive, but if supply T = initial T, it remains that T because no net heat or work, just mass added at same energy per unit mass as inside). If the supply was hot, the tank warms to that enthalpy level; if supply was cold (like adding cooler fluid), the tank cools. Another scenario: **discharge a tank adiabatically**. The gas inside does work to push gas out. That work is accounted by the enthalpy carried by exiting mass. For a rigid adiabatic tank emptying (like blowing down), the equation might be $U_f - U_i = -m_{\text{out}} h_{\text{out}}$ (no heat, no shaft work, but mass leaves carrying energy out, thus negative). That leads to a drop in internal energy of what's left inside (and usually a temperature drop).
8. **Solve for the desired quantity:** Often you'll be solving for a final temperature or a heat transfer. Use property relations to connect U or H changes to temperatures, etc. For ideal gases, use $u = c_v T$, $h = c_p T$ or maybe tables for more complex gases. For water/refrigerants, use steam tables for internal energy and enthalpy. The process might be constant volume (rigid tank) which means all work is flow work already counted in enthalpy terms, etc. If it's a closed transient (like a piston compressing a gas slowly while cooling), you'd do $Q - W = \Delta U$ between states (since no mass crosses, just treat it like a fancy closed process where maybe you find work from area under curve or so).

Let's apply this to a concrete example: **Charging a rigid insulated air tank**. Suppose a 2 m³ empty tank is connected to a high-pressure air line at 500 K, 5 MPa. The tank is initially evacuated (vacuum). The valve is opened, air flows in until the tank reaches 5 MPa, then the valve is shut. What is the final temperature in the tank? We assume ideal gas and no heat loss, no external work. - System: air in tank. - Initial: $m_i = 0$, $U_i = 0$ (vacuum has no energy). - Final: m_f unknown, $U_f = m_f u_f$. - Inlet: air enters from line at 5 MPa, 500 K (we can get $h_{\text{in}} = c_p * 500$ K or just call it h_{in}). - Energy balance: $U_f - 0 = m_f h_{\text{in}} \Rightarrow m_f u_f = m_f h_{\text{in}} \Rightarrow u_f = h_{\text{in}}$. For ideal air, $u_f = c_v T_f$ and $h_{\text{in}} = c_p T_{\text{in}}$. So $c_v T_f = c_p * 500$ K. Thus $T_f = \frac{c_p}{c_v} * 500\text{ K} = \gamma * 500$ K. If $\gamma = 1.4$ (diatomic), $T_f = 1.4 * 500 = 700$ K. So the tank ends up quite hot (air entering at 500 K led to 700 K inside!). Why so? Because as high-pressure air rushed in and filled the vacuum, it didn't expand and cool – instead, all that enthalpy got stuck as internal energy raising temperature. This result could be found quickly by that enthalpy-internal energy reasoning. If you had tried to treat it as steady or something, you'd likely get confused. So knowing the transient approach yields the correct, perhaps non-intuitive result that T increased. A check: The pressure equalized at 5 MPa with the same moles now in larger volume (the tank) – one might guess it'd cool (free expansion type idea), but free expansion here is tricky because the supply pushes the gas in. The energy analysis sorts it out correctly.

Another example: **Cooling a closed cylinder with a paddle wheel** – maybe a gas is stirred (work input) while being cooled to keep temperature constant. This is transient (start and end states known, process details maybe complicated but overall energy in/out calculable). If initial and final states are the same temp (isothermal), then $\Delta U = 0$. So first law gives $0 = Q - W \Rightarrow Q = W$. Meaning all the work input via the paddle wheel went out as heat. The exam could frame this as: "A well-insulated rigid tank with gas is stirred by a paddle wheel, raising its internal energy by 10 kJ. Meanwhile, 10 kJ of heat is removed by a cooling coil. What is the final temperature change?" Answer: zero change (the heat removed equals work in, net $\Delta U = 0$). This is an example of using energy balance in an *open* way: even if the process is complicated (work in + heat out simultaneously), only the net matters for state change.

In general for the FE, **transient problems reduce to:** Energy in (heat + enthalpy of mass in) minus energy out (work + enthalpy of mass out) = change in energy inside (usually internal energy change, plus maybe KE/PE if something like a rocket launching – but that's unlikely in FE context beyond perhaps a conceptual question).

To avoid confusion, clearly define what's entering or leaving and what's staying. A common error is double-counting energy. For example, in the filling tank scenario, some might try to add a work term for "pushing fluid in." But note: the work to push fluid in is already accounted by the enthalpy h_{in} of the fluid (recall $h = u + Pv$, and that Pv term is the flow work needed to push fluid across the boundary). So you should **not** separately add a $P\Delta V$ work term for the incoming fluid – doing so would count the flow work twice. Using enthalpy for convective flows automatically takes care of that. Similarly, if mass leaves, don't try to subtract a $P\Delta V$ for the exit – the leaving mass's enthalpy term covers the energy it carries (including the work it does to get out).

Sanity checks for transient processes:

- If no mass, no heat, no work crosses the boundary (an isolated system), then energy inside doesn't change: $E_f = E_i$. (You'd be surprised, sometimes people forget and try to plug numbers – just remember isolated means constant energy, always a good check.)

- If a system is filled with mass until states equalize with source and it's adiabatic (like the air tank example), expect the final temperature to be at or above the source temp for gases (above if source did pressure-volume work on the fluid as it entered). If you got something very different, reconsider.

- If something empties adiabatically, expect cooling of what's left (e.g. an aerosol can gets cold as you spray it – classic expansion cooling, which is essentially transient as the can empties). If a calc gave a final temperature higher than initial in an adiabatic expansion, likely an error.

- Check extreme cases: in the air tank fill, if the supply pressure was just equal to initial tank pressure (no actual driving force), nothing would flow – no change, which should come out of the equations accordingly. Or if the tank volume was extremely large, the final pressure might not reach supply pressure fully in a finite mass addition, etc. But exam problems usually simplify to nice cases.

In summary, for transient energy problems: **Write an energy balance between initial and final states including any mass flows.** Treat it like a big "before and after" accounting. It's the same first law principle, just acknowledging that energy can pile up or dwindle in the system rather than everything balancing out instantaneously. Keep track of what mass/energy enters and leaves during the process, and equate that to the change in stored energy. With that, even if the process is complex, you can get the answer by focusing on the initial and final snapshots – a powerful approach that spares you from unnecessary complication on exam day.

Topic 03 - Laws of Thermodynamics

Topic Introduction: The *laws of thermodynamics* are the fundamental principles governing energy, heat, and entropy in any process. On the **FE Mechanical Exam**, this topic is crucial: you'll apply the **First Law** (energy conservation) to analyze energy balances in closed and open systems, and the **Second Law** to determine limits of performance (like maximum possible efficiency or why certain processes are impossible). Typical questions might ask you to compute heat transfer or work using the first law, evaluate whether a scenario violates the second law, calculate an entropy change, or assume an *isentropic* (ideal no-loss) process in analyzing a power cycle. Mastering these laws means you can confidently set up energy equations and recognize the "no free lunch" constraints of thermodynamics on exam day.

K11.T03.S01 – First Law of Thermodynamics (Energy Conservation)

- **Energy can neither be created nor destroyed.** The *First Law of Thermodynamics* formalizes this: it tracks energy flowing into or out of a system and equates it to the change in the system's stored energy.
- **Closed vs. open systems:** For a *closed system* (no mass crossing the boundary), the first law reduces to a simple **energy balance** between heat Q, work W, and change in internal, kinetic, and potential energy. For an *open system* (mass flow in/out, like a pump or turbine), the first law includes energy carried by flowing matter (using *enthalpy* h to account for internal energy + flow work).
- **Sign convention matters:** By convention (as used in the exam), heat Q **added to** the system is positive, and work W **done by** the system (output work) is positive. This sign choice ensures consistency with the exam reference formulas.
- **Keep track of all energy forms:** The first law reminds you to include all relevant energy changes. In many exam problems, changes in kinetic energy ($\Delta\ KE$) and potential energy ($\Delta\ PE$) might be negligible, but if a problem involves high velocity (jet engine) or height change (hydroelectric turbine), these terms become significant.
- **Typical use:** Use the first law as your go-to equation for any thermodynamics problem involving energy transfer – it's the thermodynamic "accounting" tool to find an unknown heat, work, or change in internal energy when the other quantities are known.

First Law (Closed System) – *Energy balance for a fixed-mass system (no mass flow).*

$$Q - W = \Delta U + \Delta KE + \Delta PE$$

- Q: heat **added to** the system (J). Positive Q means energy entering as heat.
- W: work **done by** the system (J). Positive W means the system does work on its surroundings (energy leaving as work).
- $\Delta\ U$: change in internal energy of the system (J). (Depends on temperature change and phase; for an ideal gas, $\Delta\ U = m\,c_v\,\Delta\ T$.)
- $\Delta\ KE$: change in kinetic energy of the system (J), usually $\frac{1}{2}\ m\ (V_{2^2} - V_{1^2})$.
- $\Delta\ PE$: change in potential energy of the system (J), usually $m\ g\ (Z_2 - Z_1)$.

Assumptions: Applies to any process in a closed system (no mass crossing the boundary). Energy can pass through the boundary only in the form of heat or work. **All forms of energy** (internal, mechanical, etc.) are accounted for – no "hidden" losses or gains. (Chemical or nuclear energy changes, if any, are contained in $\Delta\ U$.) The sign convention is crucial: be consistent with Q in and W out as positive, as defined above.

Limit checks: If **no heat is added** ($Q = 0$, an adiabatic process), the equation becomes $-W = \Delta\ U + \Delta\ KE + \Delta\ PE$, meaning the system does work at the expense of its internal/kinetic/potential energy. If **no work is done** ($W = 0$, e.g. a rigid, sealed container), then $Q = \Delta\ U + \Delta\ KE + \Delta\ PE$ – any heat input just increases the system's stored energy. In many closed-system problems, $\Delta\ KE$ and $\Delta\ PE$ are zero (no change in speed or elevation), simplifying to $Q - W = \Delta\ U$. Always double-check: if something is stationary and not moving vertically, you can safely drop KE and PE terms.

Use vs. open system: Use this **closed-system form** for sealed systems or cycles where you analyze a fixed mass (e.g. a piston-cylinder that doesn't leak mass). **For flowing systems**, you'll use the open-system (control volume) version of the first law, which introduces *enthalpy*. Enthalpy h is defined as $U + PV$ and conveniently packages internal energy + flow work.

Common exam traps: One common mistake is *sign confusion* – for example, treating W as work **on** the system. Remember, here W is work done *by* the system (outward). If the problem states work done *on* the system, that would be a negative W in this formula. Another pitfall is neglecting kinetic or potential energy changes when they are actually important: e.g. if a problem involves a fast-moving fluid or a significant height difference, include those terms. Finally, watch your units – ensure all energy terms are in consistent units (usually J or kJ). For instance, if you use mgh for potential energy with m in kg, g in m/s², and h in m, you'll get Joules, which is compatible with Q and W if they're in J. If instead you plug numbers that give you kJ for one term and J for another, you'll be off by a factor of 1000. **Always convert or keep track of kilo- vs base units.**

Open System (Steady-Flow Energy Equation) – *Energy balance for a control volume with mass flow (e.g. turbines, pumps, nozzles).* Per unit mass of fluid, a steady-flow system obeys:

$$q - w = \Delta h + \Delta\left(\frac{V^2}{2}\right) + g\,\Delta Z,$$

where all terms are expressed on a **per mass** basis (e.g. $q = Q/m$, $w = W/m$). Here, $\Delta h = h_e - h_i$ is the inlet-to-exit change in specific enthalpy (kJ/kg), $\Delta\ (V^2/2)$ is the change in kinetic energy per unit mass, and $g\ \Delta Z$ is the change in potential energy per unit mass. This form is handy for devices like turbines (often adiabatic with significant work output) or nozzles (convert enthalpy into kinetic energy). **Enthalpy** h accounts for internal energy + flow work ($h = u + Pv$), so it naturally appears when mass crosses the boundaries. In solving open-system problems on the FE exam, you'll typically: identify inlet and outlet states, list h, V, Z for each (using tables or ideal gas laws for h), and plug into the above equation (dropping negligible terms as appropriate). For example, in a **turbine** you often set $q \approx 0$ (adiabatic), $\Delta\ Z = 0$ (no height

change), $\Delta\ (V^{2/2})\ \approx\ 0$ (if shaft work dominates over kinetic energy change), then $-w\ \approx\ \Delta\ h$, meaning work output equals the drop in enthalpy. In a **pump** or **compressor**, W would be input work, and similarly $w\ \approx\ -\Delta\ h$ (enthalpy increase). The open-system first law is essentially the same conservation of energy principle, just extended to flowing fluids. Always apply the appropriate form: closed vs. open, depending on whether mass enters/leaves your system.

Exam Handbook Search Cues (Not affiliated with or endorsed by NCEES): *First Law, energy balance, closed system, steady-flow, control volume, enthalpy.* (These keywords will point you to the first law formulas and definitions in the exam reference.)

Notes: Keep in mind that *work W may have different forms*: boundary work (e.g. $P\Delta\ V$ work in piston), shaft work (in rotating machinery), electrical work, etc. The first law doesn't care about the form – just account for all work crossing the system boundary. Also remember that the first law **does not** tell direction of energy transfer or whether a process can happen (that's second law territory); it simply balances magnitudes. It's like a **financial ledger** for energy: it must balance, but it doesn't tell you if a transaction is allowed or efficient.

Explanation: The first law is essentially the conservation of energy: when you account for all energy transfers into and out of a system (heat added minus work done out) the result equals the change in the energy stored within the system. In an exam problem, you'll usually use this to find one missing term given the others. For instance, you might be given the heat added and the internal energy rise in a piston-cylinder, and be asked to find the work done by the piston. You'd set $Q\ -\ W\ =\ \Delta\ U$ (assuming no KE/PE change) and solve for W. Or, in a steady-flow device like a nozzle, you might use $h_i\ +\ \frac{V_i^2}{2}\ =\ h_e\ +\ \frac{V_e^2}{2}$ (a form of the steady-flow equation with $q = 0,\ w = 0$) to find the exit velocity V_e. The key steps are: **(1)** Clearly define your system (closed or open). **(2)** Write the energy balance including all relevant terms. **(3)** Cancel out terms that are zero (based on the process description: e.g. "rigid container" $\Rightarrow\ W = 0$; "well-insulated" $\Rightarrow\ Q = 0$; "no change in elevation" $\Rightarrow\ \Delta\ PE = 0$; etc.). **(4)** Solve for the unknown. The first law is straightforward arithmetic once you include the correct terms; the challenge is often in identifying which terms drop out and keeping the sign convention straight.

Analysis: Let's break down the closed-system energy equation term by term.

Q **(heat):** This represents thermal energy crossing the system boundary due to a temperature difference. If you add heat to the system ($Q > 0$), it tends to raise the system's energy (increasing U, KE, or PE). If the system loses heat ($Q < 0$), the system's internal energy or other forms must drop.

W **(work):** This is energy crossing the boundary by any work mode. Work done *by* the system ($W > 0$ in our sign convention) means the system is doing something like pushing a piston or spinning a turbine, thereby expending some of its energy to the surroundings. Work done *on* the system would be a negative W in the equation (because it effectively adds energy to the system).

$\Delta\ U$ **(internal energy change):** Internal energy is associated with the microscopic energy in the substance (related to temperature, phase, chemical state). Increasing a system's temperature, for example, increases U. For ideal gases, $\Delta\ U\ =\ m\ c_v\ \Delta\ T$. For phase changes (like boiling), U changes with the latent heat.

$\Delta\ KE$ **(kinetic energy change):** $\frac{1}{2}\ m\ (V^2)$ captures the macroscopic motion of the system. Often a closed system is stationary (no bulk velocity change), making $\Delta\ KE = 0$. But if a problem involves something like a projectile or fluid being expelled, KE might matter.

$\Delta\ PE$ **(potential energy change):** $m\ g\ Z$ accounts for energy due to position in a gravitational field. Lifting a system (increase in Z) stores energy (positive $\Delta\ PE$), while lowering releases energy. In many problems, the system might remain at the same elevation or the weight change is negligible, so $\Delta\ PE = 0$. After writing down $Q\ -\ W\ =\ \Delta\ U\ +\ \Delta\ KE\ +\ \Delta\ PE$, you interpret it like: any heat that went in either left as work or stayed in the system as increased U, KE, and/or PE.

The open-system version similarly equates heat and work transfers to changes in flow energy. For a control volume at steady state,

$$\dot{m}\left(h_i+\frac{V_i^2}{2}+gz_i\right)+\dot{Q}_{\text{in}}=\dot{m}\left(h_e+\frac{V_e^2}{2}+gz_e\right)+\dot{W}_{\text{out}}$$

(where $\dot{m}$is the mass flow rate). This looks complicated, but term-by-term it says: the energy flowing in with the mass plus any heat in equals the energy flowing out with the mass plus any work out.

Here h (enthalpy) already includes internal energy, so it's analogous to $U\ +\ PV$ for each flowing stream. On the exam, you'll rarely need to write the full generalized equation; instead, recall simplified forms for common devices (they are often given in the reference as "special cases").

For example, **turbine:** $Q \approx 0, \Delta\ KE \approx 0, \Delta\ PE = 0 \Rightarrow\ W_{\text{out}}\ \approx\ m(h_i\ -\ h_e)$.

Or **pump:** $Q \approx 0, \Delta\ KE \approx 0, \Delta\ PE$ small $\Rightarrow\ W_{\text{in}}\ \approx\ m(h_e\ -\ h_i)$. The first law provides a powerful consistency check too: if you ever calculate a result where energy isn't balanced (say you found more work output than the heat drop or internal energy release can account for), you know something's wrong – you've essentially "created" energy, which violates the first law. In summary, **use the first law as the backbone of solving thermo problems:** write down energy in = energy out, minus any changes in storage, cancel what you can, and solve for the unknown. It's straightforward, but demands careful attention to detail and units.

K11.T03.S02 – Second Law of Thermodynamics (Entropy & Irreversibility)

- **Beyond energy: introducing entropy.** The *Second Law of Thermodynamics* introduces a new property called **entropy** (S) to quantify the "spread" or dispersal of energy. It distinguishes reversible (ideal) processes from irreversible (real) ones by stating that entropy of an isolated system (or the universe as a whole) can only stay the same or increase. In any real process, *entropy increases* – a measure of irreversibility or lost work potential.
- **Kelvin–Planck statement (heat engines):** In a repeating engine cycle, **net work output is only possible if some heat is rejected** to a cooler sink. A cycle cannot "take heat in" and come back to its starting state while turning that entire heat input into net work, some energy inevitably leaves as heat. In practical terms, **you can't get 100% of heat energy out as work** – there must always be some waste heat expelled to a cooler sink. Every heat

engine (a cyclic device receiving heat Q_H from a hot source and producing work W) will also dump some heat Q_L to a low-temperature reservoir. This limits the efficiency of the engine.

- **Clausius statement (refrigerators/heat pumps):** Heat has a natural tendency to move from **hot → cold**. Any cycle that forces heat to move **cold → hot** must be driven by **net work input** (that's what the compressor/equipment power is doing). Thus, any **refrigerator or heat pump** (which moves heat opposite to its natural direction) **requires work** to be supplied. You can't cool your kitchen by leaving the refrigerator door open, because the fridge needs an external work input (and ultimately dumps more heat out the back).
- **Implications on efficiency:** The second law sets an upper limit on how efficient any heat engine or refrigeration cycle can be. It tells us about the **impossibility of a "perfect" machine** – there's *no free lunch*. For engines, there will always be some fraction of heat you cannot convert to work. For refrigerators, you can't move heat uphill (cold to hot) without paying an energy "cost" in work. The best possible devices are *reversible* ones (no entropy generation), such as the idealized **Carnot cycle**, but even those have limited efficiency determined by temperature difference. All real devices are worse (less efficient) than this ideal limit due to irreversibilities (friction, losses, etc.). The second law essentially provides a yardstick to judge performance: if someone claims an efficiency or Coefficient of Performance beyond the Carnot limit, you know immediately it's not achievable in the real world (and not on the FE exam either!).

Kelvin–Planck & Clausius Statements: The two classic statements above are logically equivalent and often tested conceptually. Kelvin–Planck focuses on heat engines (you can't get work output without a heat sink), while Clausius focuses on refrigerators (you can't move heat from cold to hot without work). Remember that **if a process violates one statement, it violates the second law** – they are just two faces of the same coin. On the exam, a typical conceptual question might present a hypothetical machine (say, an engine that claims to have 100% efficiency or a fridge that cools without work) and ask if it violates the second law. The answer in those cases is yes, based on these statements.

Entropy and irreversibility: The second law formalizes the idea that in any real process, *total entropy increases*. Entropy, S, can be thought of as a measure of disorder or energy dispersal. In a reversible process, entropy stays constant (no net increase in disorder), but in an irreversible process, entropy rises – energy becomes more "spread out" and less available to do work. The **Increase of Entropy Principle** can be stated as $\Delta S_{\text{total}} = \Delta S_{\text{system}} + \Delta S_{\text{surroundings}} \geq 0$, with equality only for a reversible process (no entropy generation). While you typically won't be asked to calculate entropy generation on the FE, understanding this helps explain why no real engine can be 100% efficient: some entropy increase (waste) always happens, preventing complete conversion of heat to work.

Thermal efficiency and COP: To quantify performance, define **thermal efficiency** η for a heat engine and **Coefficient of Performance** (COP) for refrigerators/heat pumps: - Thermal efficiency $\eta = \frac{W_{\text{out}}}{Q_H}$ (work output divided by heat input). The second law dictates $\eta < 1$ (i.e. less than 100%). In fact, for any real engine $\eta = 1 - \frac{Q_L}{Q_H}$, meaning some fraction $\frac{Q_L}{Q_H}$ is inevitably wasted to the sink. - Refrigerator $COP = \frac{Q_L}{W_{\text{in}}}$ (how much heat is removed from the cold space per work input). Heat Pump $COP = \frac{Q_H}{W_{\text{in}}}$ (how much heat is delivered to the hot space per work input). Higher COP is better, but second law limits how high it can go for given temperatures.

Carnot Efficiency (ideal limit) – *Maximum possible efficiency for a heat engine operating between two temperatures.*

$$\eta_{\text{Carnot}} = 1 - \frac{T_L}{T_H},$$

where T_H is the absolute temperature of the hot reservoir and T_L is that of the cold reservoir. (Temperatures must be in **absolute** units: Kelvin in SI, or Rankine in USCS.) This formula gives the theoretical upper limit of η – achieved only by a *reversible* engine (Carnot engine) operating between those two temperatures. For example, if $T_H = 800\ K$ and $T_L = 300\ K$, then $\eta_{\max} = 1 - 300/800 = 0.625$ or 62.5%. No engine working between 800 K and 300 K can have a higher efficiency than 62.5%. Even Carnot's own engine (ideal, reversible) would achieve exactly 62.5%. Real engines will be lower.

- η_{Carnot}: maximum theoretical efficiency (fraction of heat converted to work) for given T_H and T_L.
- T_H: temperature of hot source (K).
- T_L: temperature of cold sink (K).

Assumptions: Engine operates in a completely *reversible cycle* between two constant-temperature reservoirs T_H and T_L. No irreversibilities, no additional heat sources. This is the Carnot cycle scenario. It's not a practical cycle (real engines aren't truly reversible), but it sets the benchmark. The formula assumes these temperatures are the constant temps of heat addition and rejection steps.

Limit check: If $T_L \to 0$ (cold sink at absolute zero – impossible in practice), then $\eta_{\text{Carnot}} \to 1$ (100% efficiency). If $T_L = T_H$ (no temperature difference, which means there's no driving force for heat flow), then $\eta_{\text{Carnot}} = 0$ (you can't extract any work if both reservoirs are at the same temperature). These limits make sense: the larger the temperature difference between source and sink, the greater the potential efficiency.

Use vs. reality: Use Carnot's formula **only to find the ideal maximum efficiency** or to check if an asserted efficiency is feasible. If a problem asks "what is the maximum possible efficiency" or "what is the Carnot efficiency" for given temperatures, apply this formula. Do **not** use it for cycles that aren't just two-temperature ones or where more information is given; in those cases, stick to the actual cycle details. Also, for real engines with given performance, don't plug their T_H, T_L into Carnot and assume they achieve it – Carnot is a theoretical limit, not an actual value unless explicitly stated to be an ideal reversible cycle.

Common mistakes: A very common mistake is forgetting to use absolute temperature. If you plug $T_{H=527^\circ}\ C$ and $T_{L=27^\circ}\ C$ directly into $\eta_{\text{Carnot}} = 1 - T_{L/T_H}$, you'll get a wrong answer – you *must* convert to Kelvin (e.g. $800\ K$ and $300\ K$ in this case). Another trap is misunderstanding what T_H and T_L are: they are the temperatures of the heat reservoirs (the source and sink), not the temperature of the working fluid at some random point, unless that fluid undergoes isothermal heat exchange at those reservoir temps. On problems, T_H might be given as "heat source at 500°C" (convert to K) and T_L as "ambient at 20°C" (convert to K). Yet another

pitfall: thinking an engine can be more efficient by clever design beyond Carnot – it cannot. If you calculate an efficiency greater than $1 - T_{L/T_H}$, you've likely misinterpreted the problem or made an arithmetic error. Check units and process assumptions.

Variations & Related Forms:

- *Thermal efficiency of any engine:* $\eta = \frac{W_{\text{out}}}{Q_H} = 1 - \frac{Q_L}{Q_H}$. This comes from the first law applied to a cycle ($Q_H = W_{\text{out}} + Q_L$ for a heat engine). It's valid for all cyclic heat engines (since whatever heat doesn't become work must be dumped). For Carnot specifically, $\frac{Q_L}{Q_H} = \frac{T_L}{T_H}$ (for a reversible cycle), hence recovering $\eta_{\text{Carnot}} = 1 - T_{L/T_H}$. Remember, η is typically expressed as a decimal or percentage. An η of 0.40 means 40% efficiency (40% of heat input is converted to work).
- *Carnot COP (Coefficient of Performance):* For refrigerators and heat pumps, the Carnot cycle gives the **max COP**. For a **refrigerator** (cooling mode), $COP_{\text{max, ref}} = \frac{T_L}{T_H - T_L}$, where T_L is the temperature you're cooling to (inside fridge) and T_H is where you dump heat (room). For a **heat pump** (heating mode), $COP_{\text{max, HP}} = \frac{T_H}{T_H - T_L}$. Notice that unlike efficiency, a COP can be greater than 1 (that's fine, it's heat moved per work, not energy out per energy in). But the difference $T_H - T_L$ in the denominator shows that the closer the two temperatures, the higher the COP – it's easier to move heat when there's little temperature lift required.
- *Reversible vs. actual:* In real-world (and exam) applications, if a problem provides an **actual efficiency** or **actual COP**, and maybe an "ideal" or "Carnot" value, you might be expected to compute a second-law efficiency or just compare to Carnot. For example, if an engine runs at 30% efficiency between 400 K and 300 K, and you know Carnot would be $1 - 300/400 = 25\%$, something's off – in fact here the engine's claimed efficiency (30%) exceeds Carnot's 25%, which is impossible. This tells you either the data is inconsistent or (more likely in an exam question) you've identified a violation of the second law. Usually, though, you'll get tasks like: "Given a heat pump delivering X kW heat with Y kW input at T_{inside} and $T_{outside}$, find its COP and compare to Carnot COP." This tests understanding that real devices have COP lower than Carnot's.

Exam Handbook Search Cues (Not affiliated with or endorsed by NCEES): *Second Law, entropy, Kelvin-Planck, Clausius, Carnot, efficiency, COP.* (These terms will help you find the second law definitions and formulas in the reference material.)

Notes: The term *"heat engine"* in exam problems usually means a cyclic device producing work from heat (think engines, turbines, etc. operating between a boiler and a condenser, or a high-temp source and ambient sink). The term *"heat pump"* or *"refrigerator"* implies a cyclic device using work to move heat from cold to hot. Also, remember that **efficiency (η) is always between 0 and 1**, and COP for refrigerators/HP is >1 typically, but there's no free lunch: a high COP (e.g. 5) just means it moves 5 times more heat than work input, which is possible if the temperature lift is small. Another second-law concept: *reservoirs* are bodies large enough that absorbing or rejecting heat doesn't appreciably change their temperature (like the ocean, atmosphere, or a big furnace) – this idealization is used in Carnot cycle analysis.

Special Notes (Calculator tips): When calculating Carnot efficiency or COP, **use absolute temperatures**. This cannot be stressed enough – your exam-approved calculator will happily compute $1 - \frac{20}{500}$ and give 0.96 (96%) if you mistakenly plug 20°C and 500°C, which is nonsense. Always convert: e.g. $20°C = 293\ K$, $500°C = 773\ K$, then $\eta_{\text{Carnot}} = 1 - 293/773 = 0.62$ (62%). Also, if computing a COP formula like $T_{L/(T_H} - T_{L)}$, use parentheses in the denominator: e.g. for $T_{L=260}\ K$, $T_{H=300}\ K$, enter 260/(300-260) to get 6.5. A common calculator mistake is to miss parentheses: 260/300-260 would be interpreted as $(260/300) - 260$, which is way off. So be careful with order of operations.

Explanation: The second law's main role in the FE exam is to guide what's *possible* and what the best-case scenarios are. You might get conceptual questions (e.g., identify which of four statements violates the second law) or practical ones (e.g., calculate the Carnot efficiency between two given temperatures, or the COP of an ideal heat pump). For problem-solving, a frequent use is computing the *ideal* efficiency or COP to set a benchmark. For example, if a question provides a power plant operating between a boiler at 500 K and ambient at 300 K, and asks for maximum efficiency, you'd use Carnot's $1 - T_{L/T_H}$. If a refrigeration question gives you temperatures and asks for min work input for a given cooling, you'd use the Carnot COP to find that theoretical limit. Another application: *entropy change calculations* (covered more in the next subtopic) can be used to check second-law compliance. For instance, if you calculate the total entropy change of a process and get a negative number, that indicates a second-law violation (which can be a trick to see if a proposed process is impossible). In cycle analysis, you use the second law implicitly whenever you assume a process is *reversible* or *isentropic* to get the best outcome. The second law matters on exam day because it prevents you from giving unrealistic answers. If you ever solve for an efficiency > 1 (or COP above Carnot), you should immediately suspect an error. Likewise, if a problem is simply theoretical, asking *why* something can't happen, you'll invoke the second law statements (Kelvin–Planck or Clausius). In summary, the second law is about **quality of energy**: it tells us not all energy is equally useful (you can't fully utilize low-grade heat), and it introduces entropy to quantify that degradation of energy.

Analysis: Let's analyze the Carnot efficiency formula and the concept of entropy in a bit more depth, as these are central to second-law reasoning. The Carnot efficiency $\eta_{\text{Carnot}} = 1 - T_{L/T_H}$ highlights a few key ideas: **(1)** Efficiency depends only on the temperatures of heat exchange. High T_H and low T_L are desirable for better efficiency – that's why real power plants strive for high steam temperatures and why rejecting heat to colder environments (like cooling water or air in winter) helps. **(2)** If you plug in some typical numbers – say $T_{H=1500}\ K$ (a really hot combustion flame) and $T_{L=300}\ K$ (ambient), $\eta_{\text{max}} = 1 - 300/1500 = 0.80$ or 80%. Even in theory, you'd lose 20% of heat to the sink at least. Most real engines then achieve maybe 30-50% due to additional losses. So, Carnot tells you even before doing any engineering details, that there's a hard cap. **(3)** The formula's reliance on absolute T is tied to entropy: a Carnot engine is one that has *no entropy generation*, and for it the heat transfers are *reversible*, meaning $\frac{Q_H}{T_H} = \frac{Q_L}{T_L}$. Rearranging that yields $Q_{L/Q_H} = T_{L/T_H}$, which directly gives $\eta = 1 - T_{L/T_H}$. So Carnot's formula is basically an expression of energy conservation *plus* no entropy generation. Now, consider entropy S. For any real engine, the fact that $Q_{L/Q_H} > T_{L/T_H}$ (inequality) is another way to say entropy is produced. The extra "wasted" potential shows up as entropy increase in the combined engine + sink system. In a practical sense,

think of entropy as a marker of irreversibility: friction, turbulence, uncontrolled heat transfer (finite ΔT heat flow) all generate entropy. This entropy generation is why real processes fall short of ideal ones. For the exam, you won't be calculating entropy generation explicitly in most cases, but qualitatively you should know that **reversible = no entropy generated = ideal best performance**, and **irreversible = entropy generated = losses present**. Another angle: the second law tells you the **direction** of processes. For example, heat *will not* flow from cold to hot naturally (Clausius statement) – that's why you can often eliminate answer choices that suggest something absurd like "heat flows from the ice water to the steam pipe" without work input. Or an engine that takes heat from a 25°C room to produce work with no other effect – that's a red flag. In calculations, always cross-check: if asked for efficiency and you compute 110%, that violates K–P (impossible), so you must have mistaken given data or formula. If asked for minimum work for a refrigerator to cool something, using the Carnot COP gives you the smallest theoretically possible W; any real device would need more. **In short, the second law is your guide to sanity checks and understanding limits.** It complements the first law: first law says you *can't win* (energy is conserved, you can't get more work out than heat in), second law says you *can't even break even* (you can't get even that same amount of work out, because some heat must be lost and entropy will increase). Always apply both: satisfy the first law, then make sure nothing you assume or calculate flouts the second law. If it does, revise your understanding of the process.

K11.T03.S03 – Entropy Change for Reversible Processes (Entropy as a Property)

Entropy (S) is a state property: It has a definite value for a given state of a substance, just like pressure or internal energy. *Entropy change* ΔS depends only on the initial and final states, not on the path taken. This means we can compute ΔS between two states from tables or equations, regardless of how the process actually occurred (reversible or not).

Reversible heat transfer and entropy: For a **reversible process**, the change in entropy of a system is equal to the heat absorbed *reversibly* divided by the temperature at which it's absorbed. In differential form, $dS = \frac{\delta Q_{\text{rev}}}{T}$. For a finite change from state 1 to 2, $\Delta S = \backslash int_1^2 \frac{\delta Q_{\text{rev}}}{T}$. This is a defining relation for entropy – essentially how we calculate entropy changes by "imagining" a reversible path.

Practical computation of ΔS: *Because S is a state function, you don't actually need an internally reversible process in reality to find ΔS; you can use any convenient reversible path to integrate dQ/T. Often, the easiest way is to use property data**: for many substances (water, refrigerants, etc.), entropy values (s) are tabulated in the exam handbook. You can directly read s_1 and s_2 and do $\Delta s = s_2 - s_1$. This is much simpler than performing an integral, especially for complicated processes.

Units and interpretation: Entropy is typically given in units of J/K (or kJ/K for a whole system) or J/(kg·K) (or kJ/(kg·K) for specific entropy). An increase in entropy ($\Delta S > 0$) means the system plus surroundings has become more disordered or that heat has been absorbed by the system. A decrease ($\Delta S < 0$) means the system lost heat (or was cooled) in a way that decreased its entropy (which is fine as long as something else gained entropy – overall entropy of the universe won't decrease).

When to use entropy change: On the FE exam, you might need to compute entropy changes for processes like: an isothermal expansion/compression of an ideal gas (use $\Delta S = Q_{\text{rev}}/T$), heating a substance from T_1 to T_2 (integrate $c_p\ dT/T$ or use tables), phase change at constant T ($\Delta S = \frac{Q_{\text{rev}}}{T_{\text{sat}}}$ for melting/vaporization), or for isentropic processes (where $\Delta S = 0$ gives a relation between states). Understanding how to get ΔS will also help you verify second law compliance (e.g., check ΔS_{total}).

Entropy Change Formula (Reversible Process) – *Calculates the change in entropy between two equilibrium states via a reversible path:*

$$\Delta S = \int_1^2 \frac{\delta Q_{\text{rev}}}{T}.$$

This integral is evaluated along any convenient **reversible** path from state 1 to 2. In words, you integrate the heat input *per* temperature over the process. For many common processes, this integration has simple forms:

- **Isothermal process (constant T):** $\Delta S = \frac{Q_{\text{rev}}}{T}$. (Heat added at a fixed temperature T.)
- **Constant-pressure heating (ideal gas or incompressible):** $\Delta S = \backslash int_{T_1}^{T_2} \frac{c_p\, dT}{T} = c_p \ln! \frac{T_2}{T_1}$ (if c_p is constant over the range).
- **Constant-volume heating:** $\Delta S = c_v \ln! \frac{T_2}{T_1}$ (ideal gas, constant c_v).
- **Phase change at T_{sat}:*** $\Delta S = \frac{\Delta H_{\text{phase}}}{T_{\text{sat}}}$, where ΔH_{phase} is the latent heat (e.g. heat of vaporization) at that saturation temperature.

More generally, engineers rely on **entropy tables** (like steam tables) where each state's specific entropy s is listed. The difference $s_2 - s_1$ immediately gives Δs for the process *per kg* of substance.

- ΔS: change in entropy. (Units: J/K for a total system entropy change, or kJ/(kg·K) for specific entropy change of a substance.)
- δQ_{rev}: an infinitesimal amount of heat transferred *reversibly* (J). This term is not a state function on its own, but $\delta Q_{\text{rev}}/T$ can be integrated into a state function (S).
- T: absolute temperature at which the reversible heat δQ_{rev} is exchanged (K). If temperature varies during the process, it must be inside the integral. Always use **Kelvin (or Rankine)** for these calculations.

Assumptions: The formula applies to **internally reversible** processes, or more importantly, it applies for computing entropy change between two states by imagining a reversible path. The system should be in equilibrium states at 1 and 2 (so it has definable entropy values S_1, S_2). Also, any work modes other than $P\,dV$ (like electrical, stirring) need careful treatment since they don't directly appear in δQ – but those usually don't complicate entropy calculation as long as you focus on state properties. For using property tables, assume the substance is the same (no chemical reactions changing composition) and you are referencing the proper values for entropy in the correct units.

Limit check: If no heat is exchanged ($Q_{\text{rev}} = 0$) and the process is reversible adiabatic, then $\Delta S = 0$ – entropy remains constant (an *isentropic* process). If heat is added reversibly, ΔS will be positive. Interestingly, adding the *same* amount of heat yields a larger entropy increase at a lower temperature than at a higher temperature. For example, adding 100 kJ reversibly to a system at 300 K gives $\Delta S = +0.333$ kJ/K, whereas at 600 K it gives $\Delta S = +0.167$ kJ/K. This limit behavior aligns with intuition: dumping heat into something that's cold causes a bigger relative "disorder" increase than adding that heat to something hot. Also, consider extreme cases: as $T \to 0$ (near absolute zero), even a tiny Q_{rev} would give a huge ΔS, reflecting the fact that removing the last bit of heat near 0 K causes a very large change in entropy (this is related to third law of thermodynamics, though not needed for FE exam).

Use vs. shortcuts: Use this integral definition for deriving or remembering formulas, but in practice on the exam, **use available data or known formulas whenever possible**. For instance, you won't integrate from scratch if you have a table: if state 1 and 2 entropies are given by the exam handbook, just subtract them. If it's an ideal gas problem, it might be faster to use $c_p \ln(T2/T1) - R \ln(P2/P1)$ (see below) than to integrate stepwise. The entropy formula is fundamental, but the exam is about applying it efficiently.

Common mistakes: A big mistake is trying to compute entropy change by $\Delta S = \frac{Q_{\text{actual}}}{T_{\text{avg}}}$ for an irreversible or non-isothermal process. **Do not do that.** $\Delta S = Q/T$ only applies if the process is reversible *and* at constant temperature (or you perform the proper integral). If a process is irreversible, you cannot just divide the heat transfer by the temperature of something and get a meaningful entropy change for the system – you must either find a reversible equivalent path or use property values. Another frequent error is forgetting to convert temperature to absolute scale in the integration limits or in formulas – entropy calculations demand Kelvins. Students also sometimes mix up units: entropy in the tables might be given in kJ/(kg·K). If you take values in kJ/(kg·K) and subtract them, the result is in the same units for per kg entropy change. It's fine to work in those units, just be consistent. If you multiply a specific entropy change by a mass (in kg) to get total entropy change, the unit becomes kJ/K (since kg·[kJ/(kg·K)] = kJ/K). Keep track of whether you're dealing with per unit mass or total. One more pitfall: confusing entropy (S) with enthalpy (H) or internal energy (U) because all are state properties. They each have distinct meanings; entropy specifically tracks the *distribution* of energy.

Variations & Related Forms:

- *Using steam tables or property charts:* For water or refrigerants on the exam, you will often use provided tables. For example, if water is heated from saturated liquid at 100°C to saturated vapor at 100°C (boiling), you can look up s_f (entropy of sat. liquid) and s_g (entropy of sat. vapor) at 100°C in the steam tables. The entropy change per kg is $s_g - s_f$ (in kJ/(kg·K)). You need not do $\Delta S = Q_{\text{rev}}/T$ manually for phase change since the tables encapsulate that. Similarly, for superheated states, find s at each state. **Don't forget to interpolate** if the state is between listed values. The exam likely provides enough data points to avoid heavy interpolation, but be ready to do a linear interpolation if needed. (The exam handbook typically has entropy values for common pressures/temperatures – practice reading those tables.)
- *Ideal gas entropy change:* If you recall the ideal gas relations, for an ideal gas undergoing any process from state 1 to 2, the entropy change can be computed by: $\Delta s = c_p \ln\frac{T_2}{T_1} - R \ln\frac{P_2}{P_1}$, which is equivalent to $\Delta s = c_v \ln\frac{T_2}{T_1} + R \ln\frac{V_2}{V_1}$, where R is the specific gas constant ($R = c_p - c_v$). This formula assumes constant c_p and c_v over the range (a reasonable approximation for not-too-large temperature changes). You won't necessarily need to derive this on the exam, but it's handy: it comes from integrating $c_p\ dT/T$ and using ideal gas $P_{2/P_1} = (T_{2/T_1)/(V_{2/V_1)}}$. **Example:** If air (ideal gas, $R = 0.287$ kJ/(kg·K), $c_p \approx 1.005$ kJ/(kg·K)) is heated from 300 K to 600 K at a constant pressure, $\Delta s = c_p \ln(600/300) - R \ln(P_{2/P_1)}$. Here $P_{2/P_{1=1}}$ since constant pressure, so second term 0. $\Delta s = 1.005 \ln(2) = 0.698$ kJ/(kg·K). If instead it was heated at constant volume, you'd use the c_v form and $V_{2/V_{1=1}}$. These ideal gas entropy equations can save time if you remember them and the situation fits (ideal gas assumption given or implied).
- *Isentropic process:* A special case covered in the next subtopic: if a process is *isentropic*, $\Delta S = 0$. Then any entropy at state 2 equals entropy at state 1 ($s_2 = s_1$). This is a powerful relation: for example, in an isentropic expansion of steam in a turbine, if you know the inlet entropy s_1 and assume $s_2 = s_1$, you can go to the steam tables at the exit pressure and find the state that has that same entropy (you might interpolate between saturated liquid/vapor or use superheated tables) to get h_2. That h_2 then lets you find work output. So $\Delta s = 0$ becomes a tool to connect states. We'll elaborate on isentropic relations soon, but the key is: zero entropy change defines an idealized process path.
- *Entropy and diagrams:* You might see or be aware of a Temperature-Entropy (T–s) diagram. On a *T–s* plot, a reversible process will have an area under the curve equal to the heat transferred ($Q_{\text{rev}} = \int T\,dS$ gives the area). An isentropic process appears as a vertical line (since s doesn't change). While you likely won't have to sketch T–s diagrams in the exam, understanding them can help you visualize processes: e.g., heat addition moves you to the right (increasing s), adiabatic reversible moves vertical, etc. It's a nice sanity check: if you assumed a process was isentropic (vertical line) but you actually added heat, you know that can't be – adding heat would increase entropy. So use T–s logic mentally to avoid mix-ups.

Exam Handbook Search Cues (Not affiliated with or endorsed by NCEES): *entropy change, entropy (s), ds = dQ/T, steam tables, isentropic.* (In the exam reference, look for the section on entropy or the tables listing entropy values. Keywords like "Isentropic process" or "Entropy change for solids and liquids" are likely present.)

Notes: Often the exam will implicitly give you data to compute entropy change without calling it that. For instance, it might give initial and final states of water and ask for the entropy change – you then locate s_1 and s_2. Another common scenario: determining if a process is reversible or irreversible by comparing entropy changes. Example: *"Hot steel is quenched in water, calculate ΔS of steel, ΔS of water, and ΔS_{total}."* You'd find steel's entropy change via $mc \ln(T_{2/T_1)}$ (for cooling), water's via $mc \ln(T_{2/T_1)}$ (for heating),

then sum. If $\Delta S_{\text{total}} > 0$, it's consistent with second law (and indeed quenching is irreversible, entropy of universe increases). Such problems demonstrate understanding rather than tricky math. Keep an eye on units: mixing J and kJ in entropy can bite you. For example, using c_p in J/(kg·K) with T in K yields Δs in J/(kg·K). If you then compare with table values in kJ/(kg·K), you need to divide by 1000. To avoid confusion, you might choose to convert everything to kJ/(kg·K) by using c_p in kJ/(kg·K). (Many specific heats are given in kJ/(kg·K) in data sources.)

Special Notes (Calculator): If you're using the ideal gas entropy formula or $c\ \ln(T2/T1)$, note that the natural logarithm (ln) is the appropriate function (the calculator's "LN" button). Ensure you take the log of a dimensionless ratio (T2/T1 – you must use Kelvin, but the units cancel leaving a pure number). Also, be mindful of order: $\ln(T2/T1)$ is not $\ln(T2)\ /\ \ln(T1)$; it's the log of the division. Use parentheses: e.g. on a TI calculator, type ln(600/300) to get $\ln(2)$. Another tip: when interpolating entropy from tables, do it carefully as you would interpolate any other property. No special calculator function, just linear interpolation unless the table suggests otherwise. Lastly, if a question asks for entropy change in say Btu/(lbm·°R) (US units), remember 1 Btu/(lbm·°R) is a unit of specific entropy analogous to kJ/(kg·K). The process for calculation is the same, just use consistent units (e.g., use c_p in Btu/(lbm·°R) and T in °R for the formula, or use English unit steam tables).

Explanation: On the FE exam, calculating entropy changes typically comes into play in a few ways. You may be directly asked to find the entropy change of a substance given initial and final states – for example, "steam at 1 MPa, 250°C is isothermally cooled to saturated liquid at the same pressure; find the change in specific entropy." In that case, you'd get s_1 from the superheated steam table at 1 MPa, 250°C, s_2 from saturated liquid at 1 MPa (i.e. s_f at that pressure), and subtract $s_2 - s_1$. Another scenario is using entropy to solve for unknown states in *isentropic processes* (very common in cycle analysis). For instance, if an air compressor is ideal (isentropic), and you know inlet state and outlet pressure, you can use $\Delta s = 0$ along with ideal gas relations to find outlet temperature (more on that in the next section). Entropy calculations can also appear in assessing whether a process meets the second law: e.g., combining the entropy changes of two bodies to see if total entropy increased. That's more conceptual, but it could be framed quantitatively. In short, being comfortable with entropy means: knowing how to use tables for entropy values, knowing simple formulas for Δs in idealized processes, and remembering that ΔS for a system can be positive or negative, but $\Delta S_{\text{universe}}$ will be ≥0. Don't be intimidated by entropy – treat it as just another property you get from the handbook when needed, and remember the formula $dS = \delta Q_{\text{rev}}/T$ defines it but doesn't mean you must carry out crazy integrals for every problem. Often, a clever choice of a reversible path (or data lookup) makes entropy calc straightforward.

Analysis: Let's examine a quick example to solidify the concept: Say 1 kg of water at 20°C is mixed with 1 kg of water at 80°C in an insulated container (no heat lost). What is the entropy change of the universe? First, final equilibrium will be somewhere around 50°C. We find ΔS for the cold water (20→50°C) and for the hot water (80→50°C). Using an average $c \approx 4.18$ kJ/(kg·K), $\Delta S_{\text{cold}} = 4.18\ \ln(323/293)$ kJ/K, $\Delta S_{\text{hot}} = 4.18\ \ln(323/353)$ kJ/K. Compute: $\Delta S_{\text{cold}} \approx 4.18\ \ln(1.102) = 4.18 \times 0.0977 = 0.408$ kJ/K (positive, gained entropy as it was heated); $\Delta S_{\text{hot}} \approx 4.18\ \ln(0.915) = 4.18 \times (-0.0889) = -0.371$ kJ/K (negative, lost entropy as it cooled). Sum: $\Delta S_{\text{total}} = 0.408 - 0.371 = +0.037$ kJ/K. It's >0, as expected by second law (mixing is irreversible). If we had done it reversibly (e.g., via a Carnot engine exchanging heat between them while producing work), the entropy increase could have been 0. But in spontaneous mixing, some potential to do work was lost (0.037 kJ/K worth of entropy generated). This kind of analysis is not common in depth on FE, but it demonstrates how to apply dQ/T. For a more exam-relevant analysis, consider entropy in a **Rankine cycle**: steam expands in a turbine ideally isentropically from high pressure to low pressure. To find the quality or state at turbine exit, you set $s_{\text{exit}} = s_{\text{inlet}}$. If inlet is superheated, say $s_1 = 6.6$ kJ/(kg·K) at 6 MPa, 500°C, and exit pressure is 10 kPa, you go to the 10 kPa steam table. There, $s_{f(10\text{ kPa})} = 0.6493$, $s_{g(10\text{ kPa})} = 8.1482$. Since $s_{\text{exit}} = 6.6$ is between s_f and s_g, the steam is a mix of liquid/vapor. Quality $x = \frac{s_{\text{exit}} - s_f}{s_g - s_f} = \frac{6.6 - 0.6493}{8.1482 - 0.6493} \approx 0.763$ (76.3% vapor). Then you can find $h_{\text{exit}} = h_f + x\ h_{fg}$ to get the enthalpy for work calc. All that hinged on understanding $\Delta s = 0$ and reading entropy values. This is a prime example of entropy's usefulness on the exam: linking states in isentropic process assumptions to get other properties. Always be mindful: **entropy is your friend** for solving certain unknowns (like final quality or temperature in an ideal process), and it's a check on process feasibility. By confidently computing and using ΔS, you unlock solving power for thermodynamics problems that go beyond simple energy balances.

K11.T03.S04 – Isentropic Process (Reversible Adiabatic Process)

Definition of isentropic: *Isentropic* means **constant entropy**. A process is isentropic if the system undergoes no change in entropy ($\Delta S = 0$). This implies two conditions: it must be *adiabatic* (no heat exchange, so no entropy transfer) and *reversible* (no entropy generation). In short, an isentropic process is an idealized process with **no heat loss and no inefficiencies**.

Role in ideal cycles: Isentropic processes are key building blocks in idealized thermodynamic cycles (Carnot, Rankine, Brayton, Otto, Diesel, etc.). For example, in the ideal Rankine cycle, the pump compression and turbine expansion are assumed isentropic. In the ideal Brayton (gas turbine) cycle, the compressor and turbine are isentropic. Assuming processes are isentropic gives the *best possible* performance for those components – maximum work output from a turbine, minimum work input to a compressor, etc. This sets an upper benchmark; real machines have some entropy increase (inefficiency), which is often accounted for via an **isentropic efficiency** (a topic that might be elsewhere in the exam, but you should know conceptually: it's the ratio of actual work to isentropic work for a device).

Ideal gas isentropic relations: For an ideal gas undergoing a reversible adiabatic process, there are simple **relations between** P, V, **and** T. These come from combining energy conservation with no heat input and the ideal gas law. If $k = c_{p/c_v}$ (the ratio of specific heats), then:

- $P\ V^k =$ constant throughout the process.
- $T\ V^{k-1} =$ constant, and $T\ P^{\frac{1-k}{k}} =$ constant.
- Equivalently, $\frac{T_2}{T_1} = (\frac{V_1}{V_2})^{k-1} = (\frac{P_2}{P_1})^{\frac{k-1}{k}}$. These formulas allow quick calculation of the final state after an isentropic compression or expansion of an ideal gas, given the initial state and either the pressure ratio or volume ratio.

Significance of k (gamma): The exponent $k = c_{p/c_v}$ typically is around 1.4 for diatomic gases like air (at moderate conditions) and 1.67 for monatomic gases (like helium). k appears in isentropic formulas because it characterizes how the gas stores energy and how pressure relates to temperature when compressed or expanded without heat. For instance, a higher k (more heat capacity in pressure work relative to internal) results in a steeper increase in temperature upon compression.

Isentropic = ideal benchmark: Because no real process is perfectly reversible and adiabatic (there's always some friction, turbulence, or heat loss), an isentropic process is an *idealization*. In exam problems, when they say "assume the process is isentropic" or "an ideal (reversible adiabatic) turbine," they want you to use these constant-entropy relations to find unknown pressures or temperatures. It simplifies calculations and represents the theoretical limit. After you find the ideal outcome, you might be asked to compare a real outcome to it (that's where isentropic efficiency comes in, though that may be beyond the immediate scope here).

Ideal Gas Isentropic Relations – *For a reversible adiabatic process in an ideal gas (isentropic), pressure and volume (and temperature) obey:*

$$P_1 V_1^k = P_2 V_2^k$$

and

$$\frac{T_2}{T_1} = \left(\frac{P_2}{P_1}\right)^{\frac{k-1}{k}} = \left(\frac{V_1}{V_2}\right)^{k-1}$$

These equations let you connect state 1 and state 2 for an isentropic process. You really only need one form plus the ideal gas law to derive others, but it's useful to remember at least one version and the rest by symmetry.

- P: pressure of the gas (in Pa, kPa, or any absolute pressure unit; do **not** use gauge pressure in these formulas).
- V: volume of the gas. Often we use specific volume $v = V/m$ (in m³/kg) in these relations, which is more general (since $P\ v^k =$ const works nicely with specific volume). If using total volume V, then the constant will differ depending on mass, so it's safest to use v per unit mass.
- T: absolute temperature of the gas (K or °R).
- k: the adiabatic index, c_{p/c_v}, a dimensionless constant (for ideal gas approximation) assumed constant over the process.

Assumptions: These relations assume **ideal gas behavior** and a **reversible adiabatic process** (i.e., isentropic). That means no heat transfer ($Q = 0$) and no entropy generation (no friction, etc.). The gas' specific heats c_p and c_v (and thus k) are taken as constant over the temperature range of interest – which is an approximation but usually okay for moderate changes. If k isn't explicitly given, you can assume a typical value for the gas (the exam might give k for air or other gases if needed, or list c_p, c_v from which you compute it). Also, these formulas apply to **closed systems or individual gas parcels**. In open-system flow devices (like a nozzle or turbine) that are isentropic, you apply the same relations between states along a streamline, treating the fluid similarly.

Limit check: If a process truly has $\Delta S = 0$, these relations hold exactly. If there's even a little heat loss or friction, the actual final state will deviate: for instance, an actual expansion will produce a bit less work and a lower final volume (or higher final temperature) than the isentropic prediction because entropy increased. One extreme check: If $k = 1$ (which would imply $c_p = c_v$ – in reality this happens if specific heats become equal, like at extremely high temperature for polyatomic gases, but it's a mathematical consideration), then the PV^k relation becomes $PV^1 = const$ (which is just Boyle's law for isothermal processes). Indeed, as $k \to 1$, an "isentropic" relation would approach an isothermal relation since the gas would have so many degrees of freedom that compressing it raises temperature very little. Another check: If you set $P_2 = P_1$ (no pressure change), the formulas give $T_{2/T_1} = 1$ (so $T_{2=T_1}$, trivial) and $V_{2=V_1}$ for PV^k (also trivial) – consistent that no process happened. If you have a large pressure drop (expansion), say $P_2 \ll P_1$, the formulas predict a significant temperature drop ($T_2 \ll T_1$) – that's the basis of why expanding gases cool (like in gas refrigeration cycles). If something in your calculation yields, say, T_2 higher than T_1 for an expansion, you likely mixed up P_1 and P_2 or used the wrong relation.

Use vs. general adiabatic: Only use these *P–V–T* relations when you are told or can assume the process is isentropic (reversible adiabatic). If a problem just says "adiabatic" but doesn't say reversible or isentropic, be cautious: a plain adiabatic process might still have entropy increase (irreversible). In such a case, you cannot use $PV^k = const$ because that's specifically for reversible. For example, a free expansion into a vacuum is adiabatic but highly irreversible – $PV^{k=const}$ would not apply. On the exam, though, when they want you to use these relations, they'll usually state "isentropic" or "ideal" clearly. If the word isentropic appears, it's a green light to break out these formulas. Also, remember these formulas are for ideal **gases**. Don't try to apply PV^k to, say, steam in a turbine – steam is not an ideal gas in typical conditions (you'd use entropy values from tables instead).

Common mistakes: A common pitfall is plugging the wrong values in due to unit inconsistency or mixing up which state is 1 or 2. Always identify state 1 and state 2 clearly: e.g., state 1 might be before compression, state 2 after compression. Then P_{2/P_1} is the pressure ratio. Students sometimes invert it by accident. Another mistake is using gauge pressures; P in these formulas must be absolute. If you're given 120 kPa gauge and atmospheric pressure is 101 kPa, the absolute pressure is 221 kPa – use that in the ratio. Using gauge would yield wrong ratios. Also, be careful with k. If the problem gives you c_p and c_v, compute k accurately. If they give a value for k (like 1.4), use it directly but remember it might slightly vary with temperature – however exam problems typically assume constant k. Another trap: thinking *isentropic = constant pressure or constant temperature*. No – isentropic is its own condition (constant entropy). It's not isothermal (constant T) – in fact, except for trivial cases, an isentropic process in a substance will **change temperature** if you do work on or by it. For an ideal gas, adiabatic compression heats it up (higher T), and adiabatic expansion cools it (lower T). If someone mistakenly uses an isothermal assumption for an isentropic problem, they'll get it wrong. Keep these distinctions clear: *adiabatic* (no heat), *isentropic* (no heat + reversible, so no S change), *isothermal* (constant T), *isoenthalpic* (constant h, like a throttling valve). Each has different formulas.

Variations & Related Forms:

- *Isentropic process in solids/liquids:* For incompressible substances (like a well-modeled liquid or solid) an "isentropic" process usually just means adiabatic since there's negligible entropy change if no heat is exchanged (there's little entropy generation if it's just a free expansion, etc., but typically solids/liquids don't expand significantly adiabatically). In practice, you rarely talk about isentropic processes for liquids/solids except to say "no heat input so entropy change is zero or minimal." The main use of isentropic assumption is for gases and vapors.
- *Isentropic efficiency:* Real devices that are adiabatic but irreversible (like a real turbine or compressor) have an efficiency defined by comparing them to an ideal isentropic device. For example, **turbine isentropic efficiency** $\eta_t = \frac{\text{actual work output}}{\text{isentropic work output}}$. **Compressor isentropic efficiency** $\eta_c = \frac{\text{isentropic work input}}{\text{actual work input}}$. These formulas effectively measure how close the device comes to being isentropic. If a problem gives an isentropic efficiency and asks for actual exit state or work, you'd first find the isentropic result (with $\Delta S = 0$ relations or tables), then adjust. For instance, if a turbine has 80% efficiency, and ideal isentropic drop in enthalpy is 100 kJ/kg, then actual drop is 0.8*100 = 80 kJ/kg (the rest went to entropy generation). This might be more detailed than needed here, but just know it in case: isentropic processes set the reference for efficiency definitions.
- *Polytropic processes:* There's a more general process definition: $P\ V^n = const$ (polytropic). If $n = k$, it's the isentropic case for an ideal gas. Other values of n correspond to other processes (e.g., $n = 1$ is isothermal, $n = 0$ would be constant pressure, $n \to \infty$ constant volume). Sometimes a problem might state "the process follows $P\ V^n = const$ with n= something." If n equals the specific heat ratio k, you know it's an isentropic-like process (provided ideal gas and so forth). If not, don't apply isentropic formulas directly. For example, if given $n = 1.3$ (not equal to 1.4 for air, say), that process is not truly isentropic; maybe some heat is leaving. Just be alert that n in polytropic might equal k by coincidence or design if they intend an isentropic scenario.
- *Pressure–enthalpy diagrams for flow:* In some contexts (like compressible flow or refrigeration cycles), an isentropic process will appear as a vertical line on an *h–s* (Mollier) chart (constant entropy implies moving vertically up or down since *s* axis stays same). Also on a *T–s* diagram as mentioned, it's vertical. Visualizing these can help ensure you're using the right state values; e.g., on a Mollier diagram for steam, moving vertically down from a point (dropping *h* at constant *s*) indicates an isentropic expansion (turbine). If instead you moved diagonally, entropy would increase. The exam might not require interpreting such diagrams explicitly, but if you ever do, recall isentropic = vertical line on *T–s* or *h–s* plots.

Exam Handbook Search Cues (Not affiliated with or endorsed by NCEES): *isentropic, reversible adiabatic,* $P\ v^k$, $T_{2/T_1} = (P_{2/P_{1)(k-1)/k}}$, *specific heat ratio.* (The handbook likely lists the ideal gas isentropic relations and maybe typical k values. Use the index or search function with "isentropic" to find these quickly.)

Notes: It's worth noting that not all exam problems will explicitly say "isentropic" even if you're meant to assume it. For example, "ideal gas in a piston is compressed adiabatically from state 1 to state 2. Find T_2." If they call it an *ideal* adiabatic compression, that implies reversible (no mention of losses), so it's isentropic – use the formulas. If they just said adiabatic but give you enough info to detect irreversibility (like final temperature measured higher than isentropic would predict), then they're testing something else (maybe entropy gen or work lost). But typically, "ideal" or "reversible adiabatic" cues the isentropic assumption. Also, be mindful of the difference between **isentropic process** and **isentropic efficiency** concept – the latter is an efficiency metric, not a process itself, but the link is that you use an isentropic process as the reference to gauge performance.

Special Notes (Calculator): When using the isentropic formulas, make sure to handle exponents correctly. For example, to compute $T_2 = T_1 \left(\frac{P_2}{P_1}\right)^{(k-1)/k}$, it might be easiest to do it step by step on your calculator: 1. Compute the pressure ratio $r = P_{2/P_1}$ (a unitless number). 2. Compute the exponent $(k-1)/k$ (for $k = 1.4$, this is $0.4/1.4 \approx 0.2857$). 3. Raise the pressure ratio to that power: use the x^y key or ^ if using a computer-like syntax. E.g., on a scientific calc, enter $r^{0.2857}$. 4. Multiply the result by T_1 to get T_2. Be cautious with grouping: if you try to do it all in one chain, ensure the exponent is handled correctly. It's easy to mistype something like T1 * (P2/P1)^((k-1)/k). Write it out clearly. Similarly for $P_2 = P_1\ (V_{1/V_{2)k}}$, perhaps find $(V_{1/V_{2)k}}$ first then times P_1. These calculations are usually straightforward if you organize them. Also double-check that you're using the correct values: e.g., k for air ~1.4 (unless told otherwise). The exam might explicitly say "assume $k = 1.4$ for air" to avoid ambiguity.

Explanation: In exam problems, the phrase "reversible adiabatic" or "isentropic" is your cue to use these relations to simplify calculations. For example, suppose an ideal gas at 300 K and 100 kPa is compressed isentropically to 500 kPa. They might ask: what is the final temperature? Using

$$\frac{T_2}{T_1} = \left(\frac{P_2}{P_1}\right)^{(k-1)/k},$$

with $k = 1.4$,

$$T_2 = 300 \times (5)^{0.4/1.4} \approx 300 \times (5)^{0.2857}.$$

Calculate $(5)^{0.2857}$: it's about $5^{0.2857} \approx 1.58$. So

$$T_2 \approx 300 \times 1.58 = 475 \text{ K}.$$

That's the power of the isentropic relation – one step to get T_2. If you didn't know that, you'd have to maybe do energy balance with $Q = 0$and integrate something with c_v, which is more work. Another common use: finding work in an isentropic process. For a closed system ideal gas, the work $W = \int P\, dV$. For an isentropic process $PV^k = \text{const}$, one can derive

$$W = \frac{P_2V_2 - P_1V_1}{1-k}$$

(which is given in many textbooks). Instead of memorizing that, you can find $W$by computing $\Delta U$and using $Q - W = \Delta U$with $Q = 0$, so $W = -\Delta U$. For an ideal gas, $\Delta U = mc_v(T_2 - T_1)$, so $W = mc_v(T_1 - T_2)$(the negative sign is because work done by the gas is positive, and if $T_2 > T_1$in a compression, that Wwill come out negative meaning work was done on the gas). The point is, often if you get T_2via isentropic formula, you can subsequently find work or other quantities. In open-system devices like turbines, if it's

isentropic, you know $s_{\text{out}} = s_{\text{in}}$. So you go to the tables with outlet pressure and find the enthalpy at the same entropy (that's an isentropic drop). That gives the ideal work output per kg $\left(= h_{\text{in}} - h_{\text{out, isentropic}}\right)$. Then if an efficiency is given, you adjust. This is the typical sequence for turbomachinery problems. On simpler notes: sometimes an isentropic assumption is hidden. For instance, an "ideal nozzle" expanding a gas from high pressure to low pressure – if it's ideal, we assume isentropic flow (no losses). Then we can use T_2 from isentropic relation to find the exit velocity via energy conversion (h drop converts to $V^2/2$). Or an "ideal gas undergoing adiabatic expansion against a piston with no friction" – that phrase "no friction" implies reversible, hence isentropic if adiabatic. Recognizing these clues saves a lot of time. In summary, the isentropic process is the theoretical yardstick for the best performance. The FE exam expects you to apply isentropic formulas to get quick answers for ideal scenarios and to differentiate them from real scenarios. Always confirm that no heat is added/removed and that you're dealing with an ideal, frictionless process before using PV^k or related equations. If those conditions hold, go ahead and use them – it will make solving for unknown T, P, or V much more straightforward than using basic definitions from scratch.

Analysis: Let's illustrate with a concrete scenario:

Gas Turbine Example – Air at 300 K, 100 kPa enters an ideal compressor that raises the pressure to 500 kPa **isentropically**. Using the ideal-gas isentropic relation with $k = 1.4$,

$$T_2 = T_1 \left(\frac{P_2}{P_1}\right)^{(k-1)/k} = 300\,(5)^{0.2857} \approx 300(1.584) \approx 475 \text{ K}.$$

Now, in an ideal Brayton cycle, that high-pressure air goes into a combustor (heat addition at roughly constant pressure), then into a turbine which expands it back to 100 kPa isentropically. If it enters the turbine at $T_3 = 1200\text{K}$ and $P_3 = 500\text{kPa}$, then the isentropic turbine exit temperature is

$$T_{4s} = T_3 \left(\frac{P_4}{P_3}\right)^{(k-1)/k} = 1200 \left(\frac{100}{500}\right)^{0.2857} = 1200(0.2)^{0.2857} \approx \frac{1200}{1.584} \approx 758 \text{ K}.$$

So the air cools from 1200 K to about 758 K in the **ideal** turbine expansion. If we compared this to a real turbine with, say, 85% isentropic efficiency, the real exit temperature would be higher (smaller drop): using $\eta_t \approx (T_3 - T_4)/(T_3 - T_{4s})$, $T_4 \approx 1200 - 0.85(1200 - 758) \approx 824\text{K}$. This example shows how you can chain the isentropic formula for both compression and expansion steps in a cycle analysis.

Sanity check: For an ideal-gas isentropic step, using

$$\Delta s = c_p \ln\left(\frac{T_2}{T_1}\right) - R\ln\left(\frac{P_2}{P_1}\right),$$

the result should be ~0. Small nonzero values typically come from rounding T_2 or using inconsistent c_p and R. Use full calculator precision for the temperature ratio (and consistent units for c_p and R).

Good, so entropy didn't change, as expected. This highlights the importance of doing the calculation accurately. On the exam, you'll likely have a calculator, so you can get the precise value. Always better to compute than rely on memory or too rough estimation for final answers. The takeaway is: trust the formula, plug in carefully.

In summary, an isentropic process is your ideal model for no-loss compression/expansion. Knowing how to apply PV^k and related formulas quickly will save you time and help ensure you get questions right when they hinge on "ideal" processes in thermodynamics.

Topic 04 - Processes

Topic Introduction – Thermodynamic Processes: Thermodynamic processes describe how a system's state (pressure, volume, temperature, etc.) changes, and they dictate energy exchanges like work and heat. On the FE Mechanical Exam, you'll encounter problems asking for work done during gas expansion/compression, changes in entropy for a given process, or energy balances in steady-flow devices (turbines, nozzles, pumps, heat exchangers). Mastering these processes means you can quickly recognize which formulas to apply – for example, computing the **boundary work** from a P–V diagram, or using **enthalpy** in open-system energy equations. Typically, exam questions give initial and final states along with a process type (e.g. "isothermal expansion" or "adiabatic compression") and ask for quantities like work W, heat Q, or entropy change ΔS. The key is to identify the process, apply the right relationship (like $PV^{*}const$ for polytropic or $\Delta S = 0$ for isentropic), and carry out a consistent calculation. In this chapter, we break down the core formulas and features of common processes – providing a "passport" for each that highlights when to use it and how to avoid pitfalls on exam day.

K11.T04.S01 – Boundary Work for Closed Systems

Principle Introduction (Process Work): In a **closed system**, boundary work (also called **process work**) is the energy transferred as work when the system's volume changes under pressure. Key points to remember include:

- Boundary work is **area under the P–V curve** for a process. If you have a pressure-volume diagram, the work done by the system equals the area between the process path and the volume axis.
- It applies to quasi-equilibrium processes where the system's pressure P is well-defined at the boundary as the volume V changes. Think of a piston-cylinder: as the piston moves, the gas does work on it (expansion) or the piston does work on the gas (compression).
- The sign convention (for the FE Exam) usually takes *work done by the system* as positive. So expansion (V increase) gives positive W, and compression (V decrease) gives negative W – keep this in mind when plugging into the first law.
- On exam day, you might be given two states and told the process type (e.g. isobaric or isothermal) – you'll select the appropriate form of the work equation to compute W. Make sure to use **absolute pressure** (not gauge) and convert units so that P and V are consistent (SI units yield J or kJ for work; US units yield Btu if P in psi and V in ft³, etc.).

Equation Passport – Boundary Work (Closed System) – computes the work done by a closed system as it undergoes a volume change under pressure:

Formal definition: *Boundary Work* – the integral of pressure with respect to volume change, representing energy transfer as work during expansion or compression of a closed system.

Equation (integral form):

$$W = \int_{V_1}^{V_2} P \, dV .$$

(The area under the P–V curve from initial volume V_1 to final volume V_2.)

Variables and units:

- W: total boundary work (energy transferred by work, **J** or **kJ** in SI; often **Btu** in USCS).
- P: pressure at the system boundary (force/area driving the piston movement), typically **Pa** (N/m²) in SI or **lbf/ft²** (or psi) in USCS.
- V: volume of the system (for a closed system, this is the internal volume), in **m³** (SI) or **ft³** (USCS).
- Integration limits V_1, V_2 correspond to the initial and final volumes of the process. Pressure P may be a function of V during the process.

Assumptions and scope:

- Process is quasi-static (reversible or slow enough that pressure is uniform throughout the system at each moment).
- No mass crosses the system boundary (closed system), so this work is solely boundary (expansion/compression) work. (Other work forms like electrical or shaft work would be added separately if present, but those are zero in a pure boundary work scenario.)
- Valid for any substance as long as you know the P–V relationship during the process. For ideal gases, simple forms exist for common processes (see variations below).
- **Sign convention:** Taking the system's perspective (typical in thermodynamics), W is positive when the system does work on the surroundings (expansion). Ensure you stick to the convention used by the exam for consistency with the first law formula provided.

Limit tests (sanity checks):

- If there is **no volume change** ($V_2 = V_1$), the integral gives $W = 0$. That makes sense – no expansion means no work done.
- If pressure is **constant** (process is isobaric), P comes outside the integral, giving $W = P(V_2 - V_1)$. So a larger ΔV directly increases work linearly – double the volume change, double the work (at constant P).
- As a thought check: if volume change → 0, $W \to 0$; if pressure → 0 (e.g. expanding into a vacuum), $W \to 0$ as well. These ensure the formula behaves properly in extreme cases.

Use vs. sibling equations: *Use this boundary work equation for any closed-system process where you need the work from P–V data or a known $P(V)$ relation.* It is the most general form. **Do not** use open-system equations (which include enthalpy) for closed systems – in closed systems we use internal energy U and boundary work W separately rather than enthalpy. If dealing with a steady-flow device

(open system), you'd switch to the steady-flow energy equation instead of this integral.

Common exam traps:

- **Unit mix-ups:** Ensure pressure and volume are in compatible units. For example, if pressure is given in **kPa** and volume in **m³**, the result for W comes out in **kJ** (*since* $1\ \text{kPa} \cdot \text{m}^3 = 1\ \text{kJ}$). If you inadvertently use Pa with m³, you'll get J – which is fine, just be mindful to convert if needed. Conversely, in US units, using psi for pressure and ft³ for volume gives work in $ft \cdot lb_f$; converting to Btu might be necessary. Always check the required units of the answer.
- **Sign confusion:** The integral $\int P\ dV$ inherently gives a positive area for expansion (where $dV > 0$) and negative for compression ($dV < 0$). Students sometimes forget the sign or assume work is always positive – be careful. If a problem states "work done **on** the system", that would be the negative of the W computed by this formula (since our W is work by the system).
- **Applying the wrong form:** A classic mistake is using $W = P\Delta V$ indiscriminately even when P isn't constant. For a non-constant pressure process, you must integrate or use the appropriate formula (e.g. the polytropic formula below). Misidentifying the process path can lead to wrong work. Always confirm if pressure is constant, volume constant, etc., before using a simplified form.

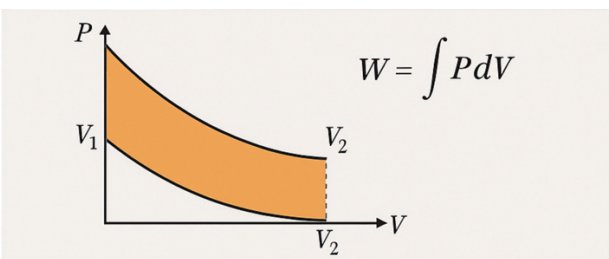

Pressure–Volume diagram for a gas expansion.

The filled area under the process curve corresponds to the boundary work, $W = \int P\ dV$. Here the gas expands from volume V_1 (at pressure P_1) to a larger volume V_2, while pressure drops from P_1 to P_2. **Key idea:** The work is equal to this shaded area. For an isobaric process, the area is a rectangle; for an arbitrary process (like the smooth curve shown), you may need calculus or given formulas to find the exact area.

Exam Handbook Search Cues (Not affiliated with or endorsed by NCEES): "boundary work", "∫ P dV", "area under P-V curve", "process work". *(These are the key terms to search in the exam handbook when looking up formulas or guidance on work in thermodynamic processes.)*

Variations and Special Cases: Boundary work formulas for specific processes (ideal gases are assumed here, as is often the case in exam problems):

- **Constant Pressure (Isobaric):** $W = P\,\Delta V = P(V_2 - V_1)$. If an ideal gas expands at constant pressure, temperature rises (heating required to keep P constant). *Tip:* This is essentially a rectangular area on the P–V diagram.
- **Constant Volume (Isochoric):** $W = 0$ because $V_2 - V_1 = 0$. No volume change means the piston doesn't move – so no boundary work. Any heat added goes entirely into changing internal energy.
- **Constant Temperature (Isothermal, ideal gas):** $W = mRT\ln\frac{V_2}{V_1}$. Here R is the specific gas constant (e.g. 0.287 kJ/(kg·K) for air) and T is constant throughout. A convenient form is also $W = mRT\ln\frac{P_1}{P_2}$ (since $P_1V_1 = P_2V_2$ for isothermal ideal gas). This logarithmic form often appears when integrating $\int P\ dV$ with $P = mRT/V$. Be mindful that it only applies to ideal gases undergoing a truly isothermal (constant T) process.
- **Polytropic process (general case):** Many processes are modeled by $PV^n =$ constant, where $n$is the polytropic exponent—a constant that defines the nature of the process. The work for a polytropic process (excluding $n = 1$ which is the isothermal case) is:

  $$W = \frac{P_2V_2 - P_1V_1}{1-n}, \qquad n \neq 1,$$

  assuming the process follows $PV^n = C$. This reduces to the above special cases: if $n = 0$, you get $W = P(V_2 - V_1)$ (constant-P process); if $n \to \infty$, $V_2 \to V_1$ and $W \to 0$ (approaching constant volume); if $n = 1$, the formula would mathematically turn into the PV log form (isothermal). The exam might directly give n or describe the process (e.g. "polytropic with $n = 1.3$"), and you'd use this formula.
- **Adiabatic, Reversible (Isentropic for ideal gas):** This is actually a subset of polytropic where $n = k = c_p/c_v$ (the ratio of specific heats). For an ideal gas, a reversible adiabatic process obeys $PV^k =$ const, and the work can be found by the same polytropic formula using $n = k$. In fact, $W = \frac{P_2V_2 - P_1V_1}{1-k}$. Because no heat is exchanged ($Q = 0$), the work comes at the expense of internal energy drop. You could also compute it via $\Delta U = -W$ for an adiabatic, closed system.

Footnotes & Key Points: *Units check:* If you use P in kPa and V in m³, the result for W comes out in kJ (since 1 kPa·m³ = 1 kJ). This is often convenient on the exam – just remember to express your answer in the asked units (J or kJ). Conversely, 1 Pa·m³ = 1 J, so keep track of factors of 1000. Also, note that these formulas give the **magnitude** of work done by the system. If a problem asks for work done **on** the system, simply take the negative of the result (or be careful with sign from the start by integrating from V_2 to V_1 for compression). Finally, when using the polytropic work formula, ensure $n \neq 1$ – if n is very close to 1, it likely implies an isothermal process and you should switch to $W = mRT\ln(V_2/V_1)$ for accuracy.

Explanation & Analysis (Step-by-Step): This boundary work equation is used in the **First Law for closed systems** (energy conservation) to account for work terms. For example, in a piston-cylinder, the first law might be $Q - W = \Delta U$ (assuming W is work done by system). Here's how you apply the concept:

1. **Identify the process:** Determine if pressure is constant, volume is constant, etc. The problem might say "20 kJ of heat is added at constant pressure" – that tells you to use $W = P\Delta V$. Or if it says "gas expands following $PV^{1.3} =$

$const$", you know it's polytropic with $n = 1.3$. Recognizing the keyword (isobaric, isochoric, isothermal, adiabatic, polytropic) is the first move. *(This is where your exam-handbook search for those terms comes in handy.)*

2. **Pick the right form of W:** Use the general integral only if needed – often, one of the simplified formulas above will apply and save time. For instance, for isothermal ideal gas, jump straight to $W = mRT\ln(V_2/V_1)$. For an adiabatic ideal gas, use $W = \frac{P_2V_2 - P_1V_1}{1-k}$. These are quicker than integrating from scratch under exam time pressure.

3. **Plug in values with careful units:** Write down P_1, V_1, P_2, V_2 (or whatever info is given). Convert to consistent units (e.g., P in Pa and V in m³ for SI to get W in J; or P in kPa and V in m³ for W in kJ). Compute the result. If using the log formula, ensure you're using natural log (the calculators on the exam all have an "ln" button, which is what you need – don't mistakenly use log base 10).

4. **Interpret the sign:** If your calculation yields W positive, that means energy leaving the system as work (expansion work done by system). A negative result would mean work done on the system (compression). Check that this matches the physical scenario described. If you find, say, $W = -50$ kJ but the problem said "the gas expanded" (which should produce positive work by our sign convention), then double-check – perhaps you flipped V_1 and V_2 or need to take absolute value and assign sign properly.

5. **Common pitfalls check:** Did you use the correct n? Did you ensure T was constant for using isothermal formula? Did you accidentally treat a process as isobaric when it wasn't? Quickly verify each assumption. For example, a quick mental check: in an isothermal expansion of an ideal gas, you expect the internal energy change $\Delta U = 0$ (since $\Delta U = mc_v\Delta T$ and $\Delta T = 0$). So all heat added goes into work output ($Q = W$). If your W came out higher than the heat given, something's off. These little consistency checks can save you from falling for a tricky trap.

By analyzing each term: P is what's pushing the boundary outward, dV is the small change in volume – multiplying gives an infinitesimal work $\delta W = P\,dV$. Summing (integrating) all those little chunks from the start to end of the process yields the total work. If P is high and volume change is substantial, work is large; if either is small, work is small – which matches intuition. Always remember: **no volume change, no boundary work**; and **no pressure (vacuum), no work**. Use those extremes to ground your understanding. Mastering this formula means you can tackle a host of questions, from finding work done during compression in an engine cylinder to estimating energy required to inflate a balloon.

K11.T04.S02 – Flow Work in Open Systems

Principle Introduction (Flow Work and Enthalpy): In an **open system** (control volume), mass carries energy as it flows in or out, and pushing mass across the system boundary involves work. **Flow work** (or **flow energy**) is the work needed to force a packet of fluid into or out of a control volume against the pressure of the fluid already inside. Key insights include:

- When a mass m of fluid enters a control volume (like water flowing into a pump or steam entering a turbine), the upstream fluid must "push" this mass in, doing work $P\,V$ on it (pressure P times the volume V that the mass occupies). Similarly, the system does work $P\,V$ on fluid leaving at pressure P.
- The **specific flow work** (per unit mass) is Pv, where v is specific volume (V/m). This has units of energy per mass (e.g. kJ/kg) and represents energy needed to make room for the fluid in the system.
- Rather than tracking flow work separately each time, engineers bundle it with internal energy to define a new property: **enthalpy**. The *specific enthalpy* h of a substance is defined as $h = u + Pv$. This single term conveniently accounts for internal energy u (the energy contained in the fluid) plus the Pv flow-work needed to move it.
- On the FE exam, whenever you analyze steady-flow devices (turbines, compressors, nozzles, heat exchangers, etc.), you will see enthalpy h in the energy equations. Remember that h is used **because** it already includes Pv work. This means: use h for open-system energy balances, and use u for closed-system energy balances. It's a subtle point, but crucial for applying the right formula.

Definition/Note Passport – Flow Work & Enthalpy

- **Plain-language definition:** *Flow work* is the work needed to push fluid into or out of a control volume, equal to pressure times volume of the fluid pushed. It's like energy you must spend to "shove" fluid into a pressurized space. **Enthalpy (h)** is the "energy content" of fluid including both its internal energy and this flow work. Essentially, $h = u + Pv$ means each unit mass of fluid carries not just internal energy u, but also an energy Pv required to make space for it at pressure P. - **Where it matters (exam impact):** In open-system problems (steady-flow devices), you will use enthalpy values from tables or equations. For example, in a turbine analysis you'll use $h_{\text{in}} - h_{\text{out}}$ to find work output, or in a nozzle you use $h_{\text{in}} + \frac{V_{\text{in}}^2}{2} = h_{\text{out}} + \frac{V_{\text{out}}^2}{2}$ (Bernoulli/energy equation form). Recognize that whenever you see an h in those formulas, it's there to simplify the account of energy – you won't separately calculate Pv work because it's already in h.

- **Pitfall or confusion point:** A common confusion is thinking you should add Pv separately in an open-system energy calculation. **Do not double-count flow work.** If you're using enthalpy, don't also add a Pv term – that term is in h. Another point: enthalpy is sometimes called "total heat content," which can mislead – it's not heat, and it's not total energy, it's specifically $u + Pv$. Stick to the definition and remember it's a property of the fluid. Also, keep an eye on units: if u is in kJ/kg and Pv comes out in kJ/kg, then h is in kJ/kg. In US units, you might use Btu/lbm for h.

- **Micro-check:** *True/False:* In a flowing system, if pressure at the outlet is higher than at the inlet, the outlet fluid has higher Pv flow energy. **(True.)** For example, pumping liquid to a higher pressure increases its enthalpy primarily by increasing the Pv portion (since u for an incompressible liquid barely changes, most energy input goes into Pv). This check reinforces that raising pressure at constant temperature raises enthalpy due to added flow work.

Exam Handbook Search Cues (Not affiliated with or endorsed by NCEES): "enthalpy ($h = u + Pv$)", "flow work", "open system work term". *(In the exam reference, look for the definition of*

enthalpy or sections on open systems – these keywords help locate the explanation that Pv is embedded in h.)

Footnotes:

- *Symbol notes:* Don't confuse v (specific volume, m³/kg) with V (often used for velocity or total volume). In this context, Pv uses specific volume. The exam reference typically uses lower-case v for specific volume and might denote flow work per mass as Pv.

- *Units:* $h = u + Pv$ is valid in any consistent units. For SI, u and h in kJ/kg, P in kPa, v in m³/kg works nicely because P[kPa] * v[m³/kg] = kJ/kg (same units as u). In US units, say u and h in Btu/lbm, if P is in psi you'd need v in ft³/lbm and a conversion factor (since psi*ft³/lbm gives ft·lbf/lbm, not Btu/lbm directly). In practice, you'd likely use tables that give h directly in Btu/lbm. Just be cautious to use consistent units if mixing formula input.*

- When to use internal energy vs enthalpy:* If a problem involves a closed, rigid container (no flow), use internal energy ($\Delta U = m\Delta u$) in the first law. If it's a flowing system (like a nozzle or turbine), use enthalpy changes ($\Delta H = m\Delta h$) in the energy equation. This is a direct consequence of whether flow work is present.

Explanation & Analysis: Let's connect this to the energy equation for open systems (often called the **steady-flow energy equation**, SFEE). The general energy balance for a steady-flow device (single inlet, single outlet) is:

$$Q_{\text{in}} + m\left(h_i + \frac{V_i^2}{2} + gz_i\right) = W_{\text{out}} + m\left(h_e + \frac{V_e^2}{2} + gz_e\right),$$

where subscripts i and e denote inlet and exit. Here you see h at both inlet and exit – those enthalpy terms already include the Pv flow work at each port. If we didn't use h, we would have to carry along u and Pv separately: the equation would get messier, having $u_i + P_i v_i$ for each inlet/outlet. Enthalpy streamlines it.

Term by term: h_i (enthalpy at inlet) = how much energy per kg the fluid brings in (internal + flow work), $V_i^2/2$ is the kinetic energy per kg of fluid entering, and gz_i is the potential energy per kg (if elevation difference matters). The same types of terms appear at the outlet. Q_{in} is heat added to the system, W_{out} is work delivered by the system (like shaft work out). In devices like turbines or pumps, often certain terms drop out (we'll cover that in subtopic S05).

The **physical interpretation** of flow work: imagine a fluid element about to enter a pump. The pump's inlet is pressurized with fluid. To get a new bit of fluid in, the upstream fluid (or whatever is pushing it, e.g. a reservoir at some pressure) must do work to shove it in. That work = pressure × volume of that bit of fluid. Once inside, that bit has that energy as part of its enthalpy. Conversely, when fluid leaves (say, steam exiting a boiler into a pipe), the boiler fluid does Pv work to push it out – the fluid leaving carries that energy away.

Typical exam scenario: You might be given enthalpies (from steam tables, for instance) at inlet and outlet of a turbine and the mass flow. The problem asks for work output. You'd apply $W_{\text{out}} = m(h_i - h_e)$ (assuming no heat loss, negligible kinetic/potential changes). Here you implicitly used the fact that $W_{\text{out}} = \Delta H - Q$; since $Q \approx 0$ in an ideal adiabatic turbine, $W_{\text{out}} = m(h_i - h_e)$. Notice no separate Pv terms – they're in h. If you tried to use internal energy, you'd have to know Pv for both states and it would complicate things for no gain.

So the takeaway: In any control volume analysis on the FE, **use enthalpy for energy associated with flowing fluids**. It will usually be provided (as tables or values) or easily computed (for ideal gases, $h = c_p T$ change if constant c_p). Don't go digging for Pv work terms – you already have them once you have h. This reduces errors and makes problem-solving more plug-and-chug using tabulated data or known formulas.

K11.T04.S03 – Specific Processes: Isobaric, Isochoric, Isothermal, Adiabatic, Polytropic

Principle Introduction (Common Process Types): Many thermodynamic processes are defined by a constraint that simplifies analysis. The big five to know are:

- **Isobaric:** constant pressure process.
- **Isochoric (Isometric):** constant volume process.
- **Isothermal:** constant temperature process.
- **Adiabatic:** no heat exchange. (If also reversible, it's isentropic – constant entropy.)
- **Polytropic:** a generalized process following $PV^n =$ constant.

Understanding these processes means you can recall their characteristic equations and relationships quickly. For the FE exam, this is crucial because often the problem statement will include something like "the gas undergoes an isothermal expansion" or "assume an adiabatic process," which is your cue to apply specific formulas: e.g., use $P_1V_1 = P_2V_2$ for isothermal ideal gas, or $P_1V_1^k = P_2V_2^k$ for an isentropic (adiabatic, reversible) ideal gas. Each process has unique implications for work, heat, and state variable changes:

- In an **isobaric** process, pressure stays fixed, so volume and temperature change in tandem (for a gas, volume ∝ temperature). Work is easy to find ($W = P\Delta V$), and the first law becomes $Q = \Delta U + P\Delta V$. You often supply or remove heat to maintain that constant pressure.
- In an **isochoric** process, volume is fixed, so no boundary work occurs ($W = 0$). All energy transfer is heat that goes into changing internal energy. Pressure can change freely with temperature.
- In an **isothermal** process (ideal gas), temperature is constant, so internal energy (ΔU) is zero (for ideal gas U depends only on T). That means any heat added goes entirely into work output ($Q = W$). The P–V relationship is hyperbolic ($PV =$ const).
- In an **adiabatic** process, no heat is exchanged ($Q = 0$). If it's a rapid process or well-insulated system, this applies. For an ideal gas, adiabatic + reversible implies the stronger condition of constant entropy (isentropic) with $PV^k =$ const and $TV^{k-1} =$ const, etc. Adiabatic processes have the maximum temperature change for a given work transfer (no heat to help out).
- A **polytropic** process is a catch-all model: $PV^n = C$. Different values of n replicate different behaviors (as special cases above). It's a handy way to interpolate reality (for example, a real piston process might not be perfectly adiabatic or isothermal, but something in between – that's polytropic with some n in between).

On the exam, you should match the scenario to one of these types whenever possible. It streamlines calculations. Often the problem will explicitly name the process (or imply it, e.g. "slowly enough

that heat transfer maintains constant temperature" implies isothermal). Keep the formulas for these processes at your fingertips, and know the qualitative effect on P, V, T, Q, W.

Equation Passport – Polytropic Process (General Case) – this covers the general process equation and lets you derive all special cases:

Name and purpose: *Polytropic Process Equation* – describes a process where pressure and volume follow $PV^n =$ constant. It's a unifying relation that includes isobaric, isothermal, and isentropic processes as specific cases. Use it to find the missing state variable (e.g., P_2 given P_1, V_1, V_2, and n) or to recognize process behavior.

Standard form:

$$P_1 V_1^n = P_2 V_2^n = \text{constant}.$$

This holds for any two states 1 and 2 along the process. Sometimes written $PV^n = C$.

Variables:

- P_1, P_2: initial and final pressures of the process (absolute pressure, e.g. **Pa**, **kPa**, or **psi**).
- V_1, V_2: initial and final volumes of the system (for a given mass, or you can use specific volume per unit mass) in **m³** (or **ft³** etc.).
- n: polytropic exponent (dimensionless). Its value characterizes the process: different n mean different heat/work characteristics.

Assumptions:

- The process can be modeled such that pressure and volume are related by a constant exponent n throughout. Real processes often approximate this (for example, a slow compression with some heat loss might follow $PV^{1.3} = const$ instead of the adiabatic $PV^{1.4} = const$).
- A fixed amount of ideal gas is often implied (so that $PV^n = const$ comes from combining ideal gas law and energy considerations). For non-ideal or other substances, polytropic is less straightforward, but the FE exam usually sticks to ideal gases or clearly states when to use this.
- If n is specified, assume it stays constant during the process.

Special cases (variations of n):

- $n = 0$: $PV^0 = P = const$. This is an isobaric process (constant pressure).
- $n = 1$: $PV^1 = PV = const$. This implies $P_1 V_1 = P_2 V_2$, which for an ideal gas means constant temperature (isothermal) because $PV = mRT$. So $n = 1$ corresponds to an isothermal ideal-gas process.
- $n = \gamma = k = c_p/c_v$: For an ideal gas, this yields $PV^k = const$, the **isentropic** (reversible adiabatic) process. For diatomic gases like air, $k \approx 1.4$. This case also gives constant entropy if reversible.
- $n \to \infty$: Consider the limit as n becomes very large. The equation $PV^n = const$ in the limit essentially forces V^n constant $\Rightarrow V$ constant (since the only way to keep PV^n constant with huge n is not to change V at all). Thus $n \to \infty$ is effectively an isochoric process. (You won't literally use $n = \infty$ in calculations, but it's a conceptual endpoint.)
- Other values: $0 < n < 1$ or $1 < n < \gamma$ etc. describe intermediate processes where some heat is transferred. For example, many compression processes in real engines are polytropic with n around 1.2–1.3 because they're not perfectly adiabatic (heat is lost).

Use vs. sibling equations: Use the polytropic relation whenever you see a mention of "polytropic" or a specific n value, or if you infer a process that is not purely isothermal or adiabatic but something in between. It's essentially a more general process model. If the problem explicitly says *constant temperature* or *no heat loss*, use the specialized isothermal or adiabatic formulas (which are easier). If it gives a weird exponent or states "polytropic", this is your go-to equation. Remember, once you establish P_2 via this relation, you can then compute work or heat as needed (using formulas from subtopic S01 for work, etc.).

Common exam traps:

- Using the wrong n: Don't assume $n = k$ (adiabatic) unless told reversible adiabatic/isentropic. If the problem statement says "adiabatic **and** internally reversible", then yes $n = k$. If just "adiabatic" (no heat) but the process might not be reversible, they might still intend you to use $n = k$ for ideal gas (most FE questions won't get into irreversibility for this, but be aware of wording).
- Confusing n with other exponents: For instance, the ideal gas law $PV^1 = const$ (at constant T) is a specific polytropic case; some students mix up k and n symbols. Stick to n for the process exponent unless it's the adiabatic case where $n = k = c_p/c_v$.
- Unit consistency: This relation holds using absolute pressures and volumes (or specific volumes). If volumes are given per unit mass (specific volume), that's fine – it cancels out the same way. Just don't mix intensive and extensive units (e.g., don't plug in V in m³ for one case and v in m³/kg for another without adjusting mass). Generally, it's safest to use specific volume v (so that m cancels out) or make sure you apply the formula on a per-mole or per-kg basis consistently.
- **Common linked formulas:** Once you identify a process as polytropic or one of these special cases, you might need related formulas for work or heat. We've covered work in S01. For heat, you can use first law: $Q = \Delta U + W$. For an ideal gas, $\Delta U = mc_v(T_2 - T_1)$. For example, in an isobaric process, $Q = mc_p(T_2 - T_1)$ and in an isochoric process $Q = mc_v(T_2 - T_1)$ because $W = 0$. Having these relations in mind helps answer quick conceptual questions like "which process requires more heat input to achieve the same temperature rise?" (Answer: constant pressure requires more heat than constant volume for the same ΔT, because some energy leaves as work.)

Exam Handbook Search Cues (Not affiliated with or endorsed by NCEES): "isobaric process", "isochoric", "isothermal ideal gas", "adiabatic PV^k", "polytropic PV^n". *(These keywords will*

bring up the various process relations in the reference. The handbook likely lists $PV^n = const$ and special cases, which you should be ready to use.)

Footnotes:

- *Isothermal specifics:* Remember, isothermal formulas like $P_1V_1 = P_2V_2$ strictly apply to ideal gases (where internal energy doesn't change with volume at constant T). For non-ideal or phase-change scenarios, "isothermal" doesn't guarantee PV const (e.g., boiling water is isothermal but pressure stays constant while volume changes because it's a phase change, not an ideal gas behavior). On the FE, you'll mostly encounter isothermal ideal gas situations.

- *Adiabatic vs. isentropic:* "Adiabatic" means $Q = 0$. If the process is also reversible, then entropy S is constant (isentropic). The exam may use the term "isentropic" explicitly for processes like in turbines or compressors, implying both adiabatic and reversible conditions. If they just say "adiabatic", they usually intend no heat and likely assume reversible unless otherwise stated (since irreversibility would require additional info like efficiency).

- *Constant volume or pressure:* In isochoric, since $W = 0$, any energy transfer is heat. So if you see a problem stating a gas is heated in a rigid tank from T_1 to T_2, you can immediately say $Q = \Delta U = mc_v(T_2 - T_1)$. In isobaric heating, $Q = \Delta H = mc_p(T_2 - T_1)$ (since $\Delta H = \Delta U + \Delta(PV) = \Delta U + P\Delta V$ and $P\Delta V = W$). These come straight from first law and definition of c_p, c_v. They might not be in the reference directly, but are good to recall.

Explanation & Analysis: Let's consider how to analyze a process when you identify it as one of these types:

- **Isobaric (constant P):** The process line on a P–V diagram is horizontal. If you need the work, $W = P(V_2 - V_1)$ is quick. If you need heat, use $Q = \Delta U + W$. For an ideal gas, $\Delta U = mc_v(T_2 - T_1)$ and since P constant, $W = P\Delta V = mR(T_2 - T_1)$ (because $P\Delta V = mR\Delta T$ for ideal gas). So $Q = mc_v\Delta T + mR\Delta T = m(c_v + R)\Delta T = mc_p\Delta T$. That's consistent with $Q = mc_p(T_2 - T_1)$, a handy formula for constant pressure heating/cooling. Physical sense: at constant pressure, you have to add extra heat not only to raise internal energy but also to do the expansion work. Thus $c_p > c_v$ and more heat is required than at constant volume for the same temperature change.

- **Isochoric (constant V):** The process line on a P–V diagram is vertical. There is no area under the curve, so $W = 0$. All energy transfer is as heat changing internal energy: $Q = \Delta U$. For an ideal gas, $Q = mc_v(T_2 - T_1)$. If the problem says gas in a rigid container is cooled, you know it's losing internal energy equal to heat lost, and no work term. Often this scenario appears in coupling with others (e.g., part of a cycle). Keep in mind pressure will change as T changes (by ideal gas law $P \propto T$ at constant V).

- **Isothermal (constant T, ideal gas):** Here, $\Delta T = 0$ so $\Delta U = 0$ (ideal gas internal energy depends on T only). Therefore $Q = W$ for the system (any heat in goes out as work). Use $PV = const$ to relate states: $P_2 = P_1V_1/V_2$. To get work, use the log formula $W = mRT\ln(V_2/V_1)$ or $W = mRT\ln(P_1/P_2)$. Be cautious: this formula gives work done by the system (expansion) as positive if $V_2 > V_1$. If the gas is compressed isothermally (volume decreases), the formula will yield a negative W, which correctly means work done on the system. Magnitude-wise, isothermal work can be significant – the process is taking in heat continuously to maintain temperature while doing work. A classic example: slowly compressing or expanding a gas while allowing heat exchange with a constant-temperature bath.

- **Adiabatic (no Q):** For an ideal gas, if reversible, PV^k is const and also $TV^{k-1} = const$, $T^kP^{1-k} = const$, etc. These relations let you find final T or P easily. For instance, $T_2 = T_1(V_1/V_2)^{k-1}$ and $P_2 = P_1(V_1/V_2)^k$. Because no heat enters or leaves, any change in internal energy comes from work. If the gas expands adiabatically, it cools (T drops) because it's doing work using its internal energy. If it's compressed adiabatically, it gets hot (all the work input goes into raising U). On the exam, you might use adiabatic relations in a variety of contexts: computing temperature after a gas expands in a piston without heat loss, or finding the work input to an adiabatic compressor using $W = \Delta U$ (plus considering flow, if open system). A common pitfall: forgetting that for an adiabatic *but irreversible* process (like a fast free expansion), $PV^k = const$ may not hold. The exam usually implies reversible if they expect you to use the formula.

- **Polytropic (general n):** Use the given n to relate pressures and volumes. If you need work, use $W = \frac{P_2V_2 - P_1V_1}{1-n}$ (from earlier). If you need heat, use first law: $Q = \Delta U + W$. For an ideal gas, $\Delta U = mc_v(T_2 - T_1)$ and you can find T_2 via combined gas law: since PV^n const and $PV = mRT$, you can derive T_2 in terms of T_1 and volumes (it ends up $T_2 = T_1(V_1/V_2)^{n-1}$ only if you assumed something like PV^n and ideal gas – actually that exact form is for adiabatic ($n = k$) case; for general n, there isn't a simple T relation unless you involve Q). But often they won't ask for Q in a polytropic case unless they give you n and you're expected to apply first law directly.

One *example analysis:* Suppose a question says: *"1 kg of an ideal gas expands from 500 kPa, 0.1 m³ to 100 kPa in a polytropic process with* $n = 1.3$. *Find the work done by the gas."* Approach: Recognize polytropic, use $P_1V_1^n = P_2V_2^n$ to find V_2. Here $V_2 = V_1(P_1/P_2)^{1/n} = 0.1 * (500/100)^{1/1.3} = 0.1 * (5)^{0.769} \approx 0.1 * 3.03 = 0.303m^3$. Then apply the work formula: $W = (P_2V_2 - P_1V_1)/(1 - 1.3)$. Compute numerator: $P_2V_2 = 100 \times 0.303 = 30.3$ (in kPa·m³, which is kJ), $P_1V_1 = 500 * 0.1 = 50$. So $W = (30.3 - 50)/(-0.3) = (-19.7)/(-0.3) = 65.7$ kJ (approximately). Positive sign, meaning 65.7 kJ of work done by the gas (expansion). We expect positive since volume increased. If you compare to an isothermal ($n = 1$) or adiabatic ($n = 1.4$) process between the same P_1, P_2, the work would differ – polytropic covers the in-between scenario where some heat is added but not enough to keep T constant.

In summary, classify the process, write down the defining relation (e.g. constant one of P, V, T, Q or PV^n const), then use that to find unknown state variables. From there, calculate work, heat, etc., using the appropriate formulas. Knowing these classic processes cold will make many thermo questions straightforward rather than a maze.

K11.T04.S04 – Entropy Change for Common Processes

Principle Introduction (Entropy Changes): Entropy (S) is a measure of disorder or energy dispersal, and calculating entropy change ΔS is a key part of second law analysis. For the FE Mechanical exam, you should be comfortable computing entropy changes for ideal gases in reversible processes, as well as recognizing when $\Delta S = 0$ (isentropic) or $\Delta S = \frac{Q_{\text{rev}}}{T}$ (constant temperature reservoir exchange). Common scenarios include finding the entropy change of a gas during an isothermal expansion, an isochoric heating, or determining if a process increases entropy. Key considerations:

- Use the definition for reversible processes: $\Delta S = \int_1^2 \frac{\delta Q_{\text{rev}}}{T}$.
  This means you integrate the heat transfer divided by temperature along a reversible path from state 1 to 2. For many common processes, this integral has simple forms (especially for ideal gases with constant specific heats or using standard formulas).
- **Ideal gas entropy change formulas:** If you have an ideal gas going from state 1 to 2, a very useful general formula (assuming constant heat capacities or stating in differential form) is:

  $\Delta s = c_v \ln\frac{T_2}{T_1} + R\ln\frac{v_2}{v_1}$, which is equivalent to $\Delta s = c_p \ln\frac{T_2}{T_1} - R\ln\frac{P_2}{P_1}$. Here Δs is the change in specific entropy (per unit mass). Multiply by mass to get total ΔS. This formula comes from integrating $\delta Q_{\text{rev}}/T$ for an ideal gas ($\delta Q_{\text{rev}} = mc_v dT + mRTdV/V$ for a reversible process).
- Special cases from that formula make life easier:
  If the process is **isothermal (ideal gas)**: $T_2 = T_1$, so the first term $c_v \ln(T_2/T_1) = 0$. Then $\Delta s = R\ln(v_2/v_1) = R\ln(P_1/P_2)$ (since $v \propto 1/P$ at constant T). Also, since it's reversible isothermal, $\Delta S = Q_{\text{rev}}/T$ as well, and indeed $Q_{\text{rev}} = mRT\ln(V_2/V_1)$ (from earlier) so dividing by T and by m gives $R\ln(V_2/V_1)$ which matches.
  If the process is **isochoric (constant V)**: $v_2 = v_1$, so second term $R\ln(v_2/v_1) = 0$. Then $\Delta s = c_v \ln(T_2/T_1)$. You can also think: at constant volume, $\delta Q_{\text{rev}} = mc_v dT$ (all heat goes into raising T), so $\int \frac{mc_v dT}{T} = mc_v \ln(T_2/T_1)$.
  If the process is **isobaric (constant P)**: $P_2 = P_1$, so $\Delta s = c_p \ln(T_2/T_1)$ (since second form $-R\ln(P_2/P_1) = 0$). So at constant pressure, entropy change depends only on the temperature ratio (with c_p).
  If the process is **adiabatic reversible (isentropic)**: by definition $\Delta S = 0$. And indeed, for an ideal gas undergoing a reversible adiabatic, $T_2/T_1 = (V_1/V_2)^{R/c_v}$ and plugging into the formula you'd get zero. For the exam, if they say "isentropic process," you can immediately say $\Delta S = 0$ for the system (and also no entropy generated, etc.).
  Also remember, entropy is a state function – ΔS depends only on initial and final states (for a given substance), not on how you get there (as long as you integrate along a reversible path or use property values). This means you can often take a conceptual shortcut: even if a process is irreversible, you can still find ΔS of the system by imagining a fictitious reversible path between the same states.

Why is this important on the FE exam? You might be directly asked to compute an entropy change, or to use the second law to determine feasibility (entropy generation must be ≥ 0). But more commonly, you'll need to compute ΔS for a process and maybe compare it to $\frac{Q}{T}$ of a reservoir, or use it in efficiency calculations for cycles.

Equation Passport – Ideal Gas Entropy Change (per unit mass) – to compute change in specific entropy between two states:

Name and purpose: *Ideal Gas Entropy Change Formula* – calculates the change in entropy of an ideal gas when it goes from state 1 (T_1, P_1) to state 2 (T_2, P_2) via any process (assuming constant or average heat capacities). It's useful for evaluating ΔS without needing a detailed reversible path integral each time.

Equation (specific entropy form):

$$\Delta s = c_p \ln\frac{T_2}{T_1} - R\ln\frac{P_2}{P_1},$$

where c_p is the specific heat at constant pressure (assumed constant over the range or using an average value), and R is the specific gas constant. *(Equivalently, $\Delta s = c_v \ln(T_2/T_1) + R\ln(V_2/V_1)$, which is the same relation since $R\ln(V_2/V_1) = -R\ln(P_2/P_1)$ for ideal gas.)*

Variables and units:

- Δs: change in specific entropy, in **kJ/(kg·K)** (SI) or **Btu/(lbm·R)** (USCS).
- c_p (and c_v): specific heat capacities (at const P or V). Units: kJ/(kg·K) or Btu/(lbm·R). For ideal gases, $c_p - c_v = R$.
- R: specific gas constant (e.g. 0.287 kJ/(kg·K) for air). Units: same as above (kJ/(kg·K)).
- T_1, T_2: absolute temperatures at initial and final states (**K** or **°R**; must use absolute).
- P_1, P_2: pressures at initial and final states (absolute pressure in **Pa**, **kPa**, or **psi**, etc.).
- (If using the c_v form, then V_1, V_2 are volumes or specific volumes at states 1 and 2.)

Assumptions and scope:

- The formula assumes an ideal gas with constant specific heats over the temperature range in question. If the temperature change is large and precision is needed, you might use average c_p or piecewise integration. For FE exam purposes, using given c_p or assuming constant is typically fine unless told otherwise.
- Process can be anything (reversible or irreversible) – since entropy is a state function, this formula actually gives the entropy change of the gas between the two states regardless of path, *but it was derived assuming a hypothetical reversible path*. So it's valid to compute ΔS of the gas as long as you use state 1 and state 2 properties. If the process is irreversible, ΔS_{gas} by this formula is still correct; it's the *generation* that would be something else (but exam won't likely ask for that explicitly).

- Make sure to use absolute temperature and pressure. Entropy calculations are meaningless with gauge pressure or Celsius/°F – you need Kelvin or Rankine, and absolute pressures (e.g., 1 atm = 101.3 kPa, not 0 relative).

Limit tests:

- If $T_2 = T_1$, then $\ln(T_2/T_1) = 0$. The formula gives $\Delta s = -R\ln(P_2/P_1)$. For an isothermal ideal gas process, indeed if $P_2 < P_1$ (expansion), entropy increases because $\ln(P_1/P_2) > 0$. If pressure drops, volume increases, and entropy goes up (makes sense, more volume = more disorder). If pressure rises (compression), Δs would be negative (entropy decrease for the gas, which can happen if heat is removed).
- If $P_2 = P_1$, then $\ln(P_2/P_1) = 0$, and $\Delta s = c_p\ln(T_2/T_1)$. So at constant pressure, entropy change is directly tied to the temperature ratio. Heating at constant pressure increases entropy, cooling decreases it. This aligns with expectation that adding heat increases entropy.
- If the process is adiabatic and reversible, we expect $\Delta s = 0$. Let's check: for adiabatic reversible, $P_2/P_1 = (T_2/T_1)^{\frac{c_p}{R}}$ (from isentropic relations). Plugging that in: $c_p\ln(T_2/T_1) - R\ln\left[(T_2/T_1)^{c_p/R}\right] = c_p\ln(T_2/T_1) - c_p\ln(T_2/T_1) = 0$. Good. If the process was adiabatic but not reversible, this formula doesn't directly apply to process path, but still gives difference in gas entropy (which would be >0 if entropy was generated).

Use vs. sibling equations: Use this formula to calculate entropy changes for ideal gases whenever you have initial and final T and P (or T and V). It's far faster than trying to integrate $\delta Q/T$ for each scenario. **Do not** use this for non-ideal substances or phase-change problems – there you should use property tables (e.g., steam tables give entropy values directly). Also, for liquids/solids, a simpler formula $\Delta s = c\ln(T_2/T_1)$ works (since they're incompressible, P change has negligible effect on entropy). The handbook provides that for solids/liquids. Use the ideal gas form for ideal gases only.

Common exam traps:

- **Forgetting to use absolute temperature:** This is a big one. If $T_1 = 27°C$ and $T_2 = 127°C$, you **must** convert to Kelvin (300 K to 400 K) before taking the ratio. Using 27 and 127 directly would be catastrophic. Same for pressures: use ratio of absolute pressures (e.g., if state1 is 1 atm and state2 is vacuum, don't do $\ln(0)$ – instead recognize final absolute pressure is near 0, entropy goes to infinity theoretically; but in practical problems, you won't get a true vacuum since that's unbounded entropy increase).
- **Mixing up sign or which state goes where:** The formula $c_p\ln(T_2/T_1) - R\ln(P_2/P_1)$ is straightforward if you consistently label state1 and state2. A mistake would be to plug values in wrong order – a quick fix is to remember entropy usually increases if you add heat or expand. So if your calculation yields a negative but you know the process added heat, you likely flipped something. The structure is $\ln(\text{final}/\text{initial})$ for both terms (with a minus on pressure part). Stick to that and you'll be fine.
- **Assuming $\Delta S = 0$ whenever $Q = 0$:** Caution: If a process is adiabatic ($Q = 0$), ΔS is **not** necessarily 0 – only if it's also reversible/isentropic. An irreversible adiabatic process (like a free expansion into vacuum, or an adiabatic process with friction) *does generate entropy*. The exam might test conceptual understanding: e.g., "Gas free-expands into a vacuum adiabatically – what is ΔS?" The answer is >0 because it's irreversible (you could compute it by imagining a reversible expansion between the same states). So remember: no heat exchange doesn't automatically mean no entropy change. There could be entropy produced internally. However, if the problem specifically says "reversible adiabatic" or "isentropic," then yes, $\Delta S = 0$.
- **Units confusion in c_p and R:** Ensure c_p and R are in the same unit system. For example, for air, $c_p \approx 1.005$ kJ/(kg·K) and $R = 0.287$ kJ/(kg·K). If you accidentally used R in J/(kg·K) but c_p in kJ/(kg·K), the numbers in the formula won't make sense together. Similarly in US units, if c_p is in Btu/(lbm·R), R should be in the same units (approximately 0.06855 Btu/(lbm·R) for air). The exam usually gives values or they are in the Handbook, so use those and keep consistent.

Exam Handbook Search Cues (Not affiliated with or endorsed by NCEES): "entropy change ideal gas", "ΔS = ∫δQ/T", "Δs = c_p ln(T2/T1) - R ln(P2/P1)", "isentropic process (ΔS=0)". *(The handbook includes general entropy formulas and special-case notes; these search terms will get you to those references.)*

Explanation & Analysis: Let's illustrate with a couple of examples and reasoning:

Example 1: Reversible isothermal expansion of an ideal gas. Say 1 kg of an ideal gas expands isothermally at 300 K from 0.5 m³ to 1.0 m³. What is ΔS of the gas? Since it's isothermal, $\Delta S = R\ln(V_2/V_1)$. We need R (if it's air, $R = 0.287$kJ/(kg·K)). So $\Delta s = 0.287\ln(1.0/0.5) = 0.287\ln(2) = 0.287 * 0.693 = 0.199$ kJ/(kg·K). That's positive, as expected (expanding increases entropy). We also could do $\Delta S = Q_{\text{rev}}/T$. We can find $Q_{\text{rev}} = W$ for isothermal. If initial pressure was, say, 300 kPa (we can find it from ideal gas: $P_1 = mRT/V_1$; if m=1kg, $P_1 = 10.287300/0.5 = 172.2kPa$), then $W = mRT\ln(V_2/V_1) = 10.287300 * \ln(2) = 59.4$ kJ. Divide by T (300 K) gives $0.198kJ/K$, matching the previous result times 1 kg. Good consistency check. So the gas gains entropy because heat flowed in from the reservoir to allow it to expand isothermally.

Example 2: Cooling a rigid vessel of gas from 400 K to 300 K. Volume constant, no work, so it's isochoric. Assume 2 kg of a gas with $c_v = 0.718$kJ/(kg·K) (air's c_v). Entropy change: $\Delta S = mc_v\ln(T_2/T_1) = 2 * 0.718 * \ln(300/400) = 1.436 * \ln(0.75) = 1.436 * (-0.2877) = -0.413$ kJ/K. Negative, which makes sense: we removed heat (cooling) so the gas's entropy decreased. Where did that entropy go? It went into the surroundings (which gained entropy by the heat released). If the cooling was done by contact with a large reservoir, the total entropy change would be reservoir gain minus gas loss; you could compute the reservoir's $\Delta S = Q_{\text{out}}/T_{\text{reservoir}}$ and find the net. But for the gas alone, -0.413 kJ/K is fine. The magnitude is the same as if we integrated $\delta Q/T$: Q out = $mc_v(T_2 - T_1) = 20.718(300 - 400) = -143.6kJ$. If the cooling was done by a reservoir at, say, 300 K, that reservoir's entropy gain would be $|Q|/T = 143.6/300 = 0.479kJ/K$. Net entropy change of universe = 0.479 - 0.413 = +0.066 kJ/K, which is >0, consistent

with second law (some irreversibility likely, or simply the fact that a finite temperature difference causes entropy generation).

Example 3: Adiabatic free expansion into vacuum. This is a classic irreversible process: a partition in a tank is removed, allowing gas to expand into a vacuum side. No heat exchange ($Q = 0$) and no work done ($W = 0$, vacuum offers no resistance). The gas expands, its internal energy stays the same (ideal gas, no work, no heat => $\Delta U = 0$, so T stays the same as well in an ideal gas free expansion). So final T equals initial T, but volume increased, pressure dropped. What's ΔS for the gas? We can't use Q/T directly because process is not reversible. Instead, take initial state and final state and apply the entropy formula: initial $T_1 = T_2$ (so first term 0), $P_2 < P_1$ with ratio equal to volume ratio (say volume doubled, so P halved). Then $\Delta s = -R\ln(P_2/P_1) = -R\ln(0.5) = R\ln(2)$. It's positive. The gas's entropy increased even though no heat entered – this is entropy generated internally due to the irreversible expansion. If you plug numbers, say 1 kg of gas, $\Delta S = 0.287 * 0.693 = 0.199 kJ/K$ (same as earlier isothermal example ironically, because the state change was the same doubling volume, halving pressure, same T). The difference: in isothermal case, entropy increase came from heat absorbed from environment; in free expansion, entropy increase came from internal irreversibility. The exam might not dive that deep, but conceptually remember that entropy can increase without heat input if the process is irreversible.

From a problem-solving perspective: **when you see "entropy change,"** immediately think "I need initial and final states info." Then decide if you can use the ideal gas formula or if you should grab values from steam tables (for water/refrigerant) or use simpler formulas for solids/liquids. Apply the formula carefully with the right units. If it's a reversible process with heat exchange, sometimes it's easier to do Q/T_{constant} (like entropy absorbed by a reservoir at constant T, $\Delta S = Q/T$). But for a gas's internal entropy change, the above equations are gold.

One more note: The second law often comes in the form of **entropy balance:** $\Delta S_{\text{system}} + \Delta S_{\text{surroundings}} = \Delta S_{\text{universe}} \geq 0$. If the exam asks something like "determine if a given process violates the second law," you might compute the gas's entropy change, compute the surroundings' entropy change (e.g. if a heat Q leaves the system at some reservoir temperature), and see if total is >=0. A negative total would mean impossible. However, such questions are more common in conceptual formats. Numerically, typical tasks are finding ΔS for a given process or using isentropic conditions ($\Delta S = 0$) to link states in device calculations (like isentropic efficiency calcs in turbines/compressors, see next subtopic).

In summary, entropy change calculations boil down to using the right formula and paying attention to units and process specifics. Practice a few scenarios (like we did) to cement when entropy goes up or down. It will help you avoid mistakes and also eliminate wrong multiple-choice answers by intuition (e.g., if you know entropy must increase but one option shows a decrease, you can toss it).

K11.T04.S05 – Steady-Flow Device Processes (Nozzles, Turbines, Pumps, Heat Exchangers)

Topic Introduction (Steady-Flow Devices): Many mechanical engineering devices operate under **steady-flow** conditions, meaning the mass flow and energy flow rates are constant in time (once startup transients are over). In steady state, the system's properties don't change with time – what goes in comes out appropriately. The FE exam will test your ability to apply the steady-flow energy equation (SFEE) to various devices by *neglecting terms that are not significant and focusing on the dominant energy exchanges.* The classic devices and their key process assumptions are:

- **Nozzles and Diffusers:** Convert enthalpy to kinetic energy (nozzle) or kinetic energy to enthalpy (diffuser). We assume no heat transfer and no shaft work; the main change is in fluid velocity (kinetic energy). Nozzles drop enthalpy to raise velocity (often modeled as isentropic for ideal nozzle).
- **Turbines:** Produce work by expanding a fluid. Assume adiabatic (no heat loss) and ignore kinetic and potential energy changes (fluid speeds may change but often small relative to enthalpy drop). The big term is work output equal to the fluid's enthalpy drop.
- **Compressors and Pumps:** Consume work to raise fluid pressure (and enthalpy). Also usually taken as adiabatic with negligible kinetic energy change. Work input equals enthalpy rise of the fluid. (Pumps are just compressors for liquids; liquids are nearly incompressible so formulas sometimes use $W = v\Delta P$.)
- **Heat Exchangers:** Transfer heat between two fluid streams without external work. We assume no net work (no shaft), and ideally no heat lost to surroundings (the heat from the hot fluid goes into the cold fluid). Kinetic and potential energy changes usually negligible unless otherwise stated. The key is energy balance between the two flows: the enthalpy lost by one = enthalpy gained by the other.

Knowing what terms to drop in each case simplifies the SFEE to a form you can solve quickly. The exam might directly ask "which terms can be ignored in the energy equation for a nozzle?" or it might present a problem (like computing exit velocity of steam from a turbine given inlet/outlet conditions and assuming no heat loss) where you implicitly need to know how to simplify.

Let's formalize this with a reference table and explanation:

Table Passport – Steady-Flow Device Energy Summary

(This table outlines the dominant energy terms for common steady-flow devices, assuming one inlet and one outlet for simplicity.)

Device	Key Assumptions (Term Approximations)	Simplified Energy Relation (per unit mass)
Nozzle/Diffuser	Q ≈ 0 (adiabatic), W = 0 (no shaft work), ΔPE ≈ 0 (no big height change). Focus on ΔKE.	$h_i + \frac{V_i^2}{2} = h_e + \frac{V_e^2}{2}$. A nozzle: $V_e > V_i$ (velocity increases as enthalpy drops). A diffuser: $V_e < V_i$ (velocity decreases, enthalpy rises).
Turbine (expander)	Q ≈ 0 (adiabatic), ΔKE ≈ 0 (often, fluid velocity change is small relative to enthalpy change, or design minimizes it with good diffusers), ΔPE ≈ 0 (usually no big elevation change).	$W_{\text{out}} = h_i - h_e$. The work produced per unit mass is equal to the decrease in the fluid's specific enthalpy. (If a problem gives kinetic energy changes, use $h_i + \frac{V_i^2}{2} = h_e + \frac{V_e^2}{2} + W_{\text{out}}$, but typically they'll neglect KE so it simplifies as above.)
Compressor/Pump	Q ≈ 0 (usually adiabatic to avoid heat losses or for worst-case work calc), ΔKE ≈ 0, ΔPE ≈ 0 (unless pumping to higher elevation, but usually negligible compared to enthalpy change).	$W_{\text{in}} = h_e - h_i$. The work supplied per unit mass is equal to the rise in the fluid's specific enthalpy (e.g., raising pressure of a gas or liquid). For a pump handling liquid: $W_{\text{in}} \approx v(P_e - P_i)$ (since $h_e - h_i \approx v\Delta P$ for incompressible fluids).
Heat Exchanger (two-fluid)	W = 0 (no shaft), $Q_{external} \approx 0$ (ideally all heat from one fluid goes into the other, not lost outside), ΔKE ≈ 0, ΔPE ≈ 0 for each fluid.	Energy is conserved between streams: one stream's enthalpy drop = the other's enthalpy gain. E.g., for two streams 1 and 2 (hot out = h1e, hot in = h1i, cold in = h2i, cold out = h2e): $m_1(h_{1,i} - h_{1,e}) = m_2(h_{2,e} - h_{2,i})$. If it's a single stream with external heat source (like a boiler or condenser): $q = h_e - h_i$ (per mass) for heating (boiler) or $q = h_i - h_e$ for cooling (condenser).

Typical Exam Moves:

- **Nozzle problems:** Given inlet conditions and outlet pressure (or temperature), assume isentropic (maybe to use h drop from tables or isentropic relations) and find exit velocity. Use $V_e = \sqrt{2(h_i - h_e)}$ if no initial velocity, since $h_i - h_e = \frac{V_e^2 - V_i^2}{2}$. Watch units: if h is in kJ/kg, convert to J/kg for that calculation (multiply by 1000) so that velocity in m/s is correct.

- **Turbine problems:** Given inlet and outlet states, and mass flow, find power output: $\dot{W} = \dot{m}(h_i - h_e)$. Possibly incorporate an isentropic efficiency: if not ideal, h_e actual will be higher (less enthalpy drop) than isentropic h_e. Efficiency η_t = (actual work)/(ideal work) = $\frac{h_i - h_{e,\text{actual}}}{h_i - h_{e,\text{isentropic}}}$. The handbook gives that formula. If efficiency is given, you may have to find actual h_e or work.

- **Compressor/Pump problems:** Often ask for work input or power required: $\dot{W}_{\text{in}} = \dot{m}(h_e - h_i)$. If an isentropic efficiency η_c is given, actual work is higher than ideal (since some entropy is generated): efficiency = (ideal work/actual work) = $\frac{h_{e,\text{ideal}} - h_i}{h_{e,\text{actual}} - h_i}$ for compressor (note for compressor, $h_{e,\text{ideal}}$ is lower than actual at same outlet pressure because ideal consumes less work). For pumps, you might use $W = v\Delta P$ (in consistent units) to get work per mass or sometimes head formulas: $W_{\text{in}} = g$ Head if they give head in m.

- **Heat exchanger problems:** Typically give flow rates and inlet/outlet temperatures for two fluids, asking for one outlet temperature or required flow rate. Use mh balance: $m_{\text{hot}}(h_{hot,in} - h_{hot,out}) = m_{\text{cold}}(h_{cold,out} - h_{cold,in})$. If using specific heats and temperature change (for non-phase-change fluids): $m_{\text{hot}}c_{ph}(T_{hi} - T_{ho}) = m_{\text{cold}}c_{pc}(T_{co} - T_{ci})$. No heat lost means all heat from hot goes to cold.

Common Pitfalls:

- **Neglecting kinetic energy when it matters:** In nozzles, **don't** drop the $V^2/2$ terms! The whole point is the KE change. Conversely, in turbines/compressors, if not stated, you usually *can* neglect velocity unless given. If a problem gives a turbine inlet velocity of, say, 150 m/s, you might compare it to enthalpy change: 150 m/s is about 11.25 kJ/kg of kinetic energy (since $V^2/2$), which is probably negligible if h changes by hundreds of kJ/kg. So you could safely ignore it. But if velocities are extremely high (maybe in a jet engine context), then consider it. The exam usually signals when to include KE (like explicitly giving large velocities and asking about them).

- **Wrong sign or direction in energy balance:** Write down energy balance in a consistent way. For instance, for a turbine, many prefer $h_i = h_e + W_{\text{out}}$ (energy per mass in = energy per mass out + work per mass out). It's essentially the SFEE. If you mix up and do $h_e + W = h_i$, you might get sign reversed. A quick logic: h_i should be bigger than h_e in a turbine (fluid enthalpy drops), and that difference is positive work out. For a compressor, $h_e > h_i$, and $h_e = h_i + W_{\text{in}}$. Keep that straight: turbines **produce** work (fluid loses enthalpy), compressors **consume** work (fluid gains enthalpy).

- **Units in pump work:** If you use $W = v\Delta P$ for a pump, ensure v is specific volume (e.g., m³/kg) and ΔP is in Pa (N/m²) to get W in J/kg. Many times, it's easier to use the "head" formulation for pumps: Pump head $H = \frac{W_{\text{in}}}{g}$ (in m), or conversely $W_{\text{in}} = gH$ in J/kg (since g in m/s² times m gives J/kg). If a pump problem gives you "10 m of head increase," you can multiply by 9.81 to get ~98.1 J/kg (which is tiny, likely they mean maybe 100 m head in a bigger problem). Also, 1 kJ/kg = 1 m²/s², recall earlier note: to get velocity in m/s from enthalpy in kJ/kg, use $V = \sqrt{2\Delta h * 1000}$ because of the 1000 J per kJ.

- **Heat exchanger confusion:** In a heat exchanger, it's easy to mix up which side gains/loses. A tip: write an energy balance as "Heat lost by hot = Heat gained by cold." Ensure you use the correct temperatures for each fluid. If you accidentally use one fluid's heat capacity with the other's temperature change, that's wrong. Keep each fluid's properties separate. Also, no work term – sometimes students mistakenly try to plug into SFEE formula with a W; here $W = 0$. Just a straightforward enthalpy in = enthalpy out for combined system (with exchange internally).

- **Assuming isentropic when not stated:** While many steady devices are ideally adiabatic, they may not be reversible. If the question provides an efficiency (isentropic efficiency), that's a clue the actual process is not isentropic. Don't set h_e to the isentropic value unless explicitly said "assume isentropic." Use the efficiency formula. For example, if a compressor has 80% efficiency and you computed an isentropic outlet enthalpy of, say, 290 kJ/kg (from 270 kJ/kg inlet), the actual outlet enthalpy will be higher: $h_{e,\,actual} = h_i + \frac{h_{e,\,actual} - h_i}{\eta} = h_i + \frac{\text{ideal } \Delta h}{\eta}$. Actually for compressor, $\eta = \frac{\text{ideal work}}{\text{actual work}} = \frac{h_{e,\,ideal} - h_i}{h_{e,\,actual} - h_i}$, so $h_{e,\,actual} - h_i = \frac{1}{\eta}\left(h_{e,\,ideal} - h_i\right)$. So careful on solving that.

Exam Handbook Search Cues (Not affiliated with or endorsed by NCEES): "steady flow energy equation", "nozzle energy equation", "turbine adiabatic", "compressor/pump work", "heat exchanger enthalpy balance". *(The reference likely has a summary of special-case SFEE for these devices, possibly in a table or bullet list. Searching device names or "steady-flow" will bring those up.)*

Explanation & Analysis: Let's go device by device with a short analysis:

- **Nozzle:** Think of a rocket nozzle or even a simple converging nozzle. High-pressure, high-enthalpy fluid enters; as it expands and speeds up, its pressure and enthalpy drop. The energy conversion is enthalpy -> kinetic. The SFEE reduces to $h_i + \frac{V_i^2}{2} = h_e + \frac{V_e^2}{2}$ (assuming no heat/work). If inlet velocity is small (low), we simplify to $h_i \approx h_e + \frac{V_e^2}{2}$. So $\frac{V_e^2}{2} = h_i - h_e$. This is how you get that formula for exit velocity. For example, if steam enters a nozzle at $h_i = 3000$ kJ/kg and exits at $h_e = 2800$ kJ/kg (these would come from states, maybe found via isentropic expansion to some lower pressure), then $\Delta h = 200$ kJ/kg is converted to kinetic energy: $V_e = \sqrt{2200{,}000 \text{ J/kg}} = \sqrt{400{,}000} \approx 632$ m/s. *That's the kind of number you'd get. If asked about an ideal nozzle, you might also see the term* isentropic nozzle*, meaning assume no entropy change (max efficiency). If they give pressures and temperatures, you might first use isentropic relations or tables to find h_e (ideal). If they then mention an efficiency (say 90%), you'd then adjust h_e actual. But often, for a nozzle, they don't bother with efficiency – they just assume it's isentropic unless otherwise stated.

- **Turbine:** Picture a steam turbine in a power plant. Steam goes in hot and high-pressure, expands through turbine blades, comes out cooler and lower pressure, and the turbine shaft delivers work. Under ideal conditions (adiabatic, reversible), $s_{in} = s_{out}$ and $W_{\text{out}} = h_{in} - h_{out,\,isentropic}$. If it's not ideal, steam will exit with a bit higher enthalpy (meaning less drop, wasted potential). The SFEE (neglecting KE, PE): $h_i = h_e + W_{\text{out}}$. So $W_{\text{out}} = h_i - h_e$. If given mass flow, multiply by that to get power. For example, 5 kg/s steam, $h_i = 3200$ kJ/kg, $h_e = 2600$ kJ/kg, then each kg gives 600 kJ, times 5 kg/s = 3000 kJ/s = 3000 kW (3 MW) output. Efficiency: if actual h_e was 2700 kJ/kg (less drop), efficiency = (3200-2700)/(3200-2600) = 500/600 = 83.3%. They might ask to find actual outlet quality or enthalpy given an efficiency – so you set up $\eta_t = \frac{h_i - h_{e,\,actual}}{h_i - h_{e,\,isentropic}}$ and solve for $h_{e,\,actual}$. Always remember turbine work output makes h drop.

- **Compressor:** This is basically inverse of turbine. You put work in to raise fluid enthalpy (pressure). SFEE: $h_e = h_i + W_{\text{in}}$. If adiabatic ideal, you'd use isentropic relation to find $h_{e,\,ideal}$ for a given pressure rise. Then actual h_e will be higher (more work for same final pressure). The isentropic efficiency for compressor is defined differently (since work input): $\eta_c = \frac{\text{ideal work}}{\text{actual work}} = \frac{h_{e,\,ideal} - h_i}{h_{e,\,actual} - h_i}$. This number is typically 0.7-0.85 for real machines. On exam, a typical question: "Air at 300 K, 1 atm is compressed adiabatically to 5 atm in an ideal compressor (isentropic). Find outlet temperature." You'd use $T_2 = T_1(P_2/P_1)^{(k-1)/k}$. Or maybe they directly give h_i and ask for h_e using tables. If efficiency is given, you then adjust. Another scenario: pump raising water pressure from e.g. 100 kPa to 500 kPa. We can do $W = v\Delta P$. If $v = 0.001 m^3/kg$ (roughly water), $\Delta P = 400 kPa = 400 kJ/m^3$, then $W = 0.001 * 400{,}000 Pa = 400 J/kg$. For 1 kg/s flow, that's 400 W. If pump is, say, 70% efficient, the required shaft power = 400/0.7 = ~571 W. Also, pumps often mention head: here $\Delta P = 400 kPa$ corresponds to ~40.8 m of water head ($\Delta P/(\rho g)$). If you forget to multiply by v or use wrong units, you can be off by factors of 1000 easily.

- **Heat Exchanger:** Imagine a condenser: steam condenses, giving heat to cooling water. If no losses, the energy the steam releases equals energy water gains. Usually, they'll give something like: "Hot oil enters a heat exchanger at 120°C and leaves at 90°C, transferring heat to water that enters at 30°C and leaves at 70°C. Given flow rates, find one of the exit temps or flow." Use $m_{oil} c_{p,oil}\left(T_{oil,in} - T_{oil,out}\right) = m_{water} c_{p,w}\left(T_{water,out} - T_{water,in}\right)$. No work term. If phase change is involved (say condensing steam), use latent heats: $m_{steam}\left(h_{steam,in} - h_{steam,out}\right) = m_{water} c_{p,w}(T_{out} - T_{in})$. The trick is keeping track of which side loses heat (cooling, condensing, etc.) and which gains (heating up). Also, ensure time rates if needed (the equation works with $\dot{m}$ for continuous flow). Many mistakes happen by putting the wrong temperature difference sign. Just remember: the hot stream's enthalpy should go down (so $h_{in} - h_{out}$ is positive), the cold's goes up ($h_{out} - h_{in}$ positive), and set those equal with appropriate mass flow factors.

To cement understanding, consider *why* we can neglect certain terms: it's often order-of-magnitude. A fluid's enthalpy (with phase change or high pressure gas) can be hundreds or thousands of kJ/kg. Kinetic energy term $V^2/2$ even at 100 m/s is only 5 kJ/kg. Unless velocity is extremely high or enthalpy change is very low (like in a nozzle, enthalpy change might be moderate but velocity change big), KE can be ignored. Potential energy gz term is $9.8 kJ/kg$ per 1000 m height – negligible in most machine contexts (unless analyzing hydro turbines or high towers). So in a pump raising

water 50 m, $\Delta PE = 0.5 kJ/kg$ vs maybe 40 kJ/kg enthalpy increase – small, but not totally negligible if precise. They often explicitly say "ignore kinetic and potential energy" to guide you. If not, you can assume unless data suggests otherwise.

The steady-flow processes essentially boil down to energy bookkeeping for flowing fluids. The SFEE is the Swiss-army knife: by slashing out terms, you tailor it to the device at hand. A final word: these devices might appear combined in cycles (Rankine cycle, refrigeration cycle). While the FE doesn't dive deep into cycle analysis beyond basics, knowing each component's equation is how you'd analyze a cycle step by step. So it's not just plug in numbers; it's understanding what physically happens in each device and translating that to the simplified energy equation. If you know that, you can handle whatever variant they throw at you.

With these fundamentals and the passport info above, you should be ready to tackle any FE exam question on thermodynamic processes and steady-flow analysis efficiently and correctly. Good luck – and remember to double-check units and signs!

Topic 05 - Performance of Components

Topic Intro: This topic covers the performance of common thermodynamic components – nozzles, diffusers, turbines, pumps, compressors, heat exchangers, and refrigeration cycle parts. On the **FE Mechanical Exam**, you'll often face questions asking how these devices alter fluid properties (pressure, temperature, velocity) or how to compute work, heat transfer, or efficiency. Typical problems include finding the exit velocity of a nozzle given inlet conditions, calculating turbine work output with a given efficiency, determining outlet temperatures in a heat exchanger, or identifying what happens to refrigerant across an expansion valve. Mastering this topic ensures you can quickly choose the right energy equation or efficiency formula on exam day. Remember, each of these components has a characteristic behavior and formula – essentially its own little "passport" – that you should be ready to recall and apply under exam conditions. We'll break down each subtopic with a clear formula or concept passport so you know exactly **when and how to use it**, and avoid the common pitfalls that can trip you up under pressure.

K11.T05.S01 – Nozzles and Diffusers

Principle Introduction: *Nozzles* and *diffusers* are flow passages that change fluid velocity and pressure by altering flow area. In a **nozzle**, the cross-sectional area *decreases* in the flow direction, causing fluid velocity to increase and static pressure to drop (for subsonic flows). In a **diffuser**, the area *increases*, slowing the fluid and raising its pressure. These devices are usually analyzed as **adiabatic, no-work, steady-flow** components, so no heat is added or removed and no shaft work is done – the fluid's own energy converts between kinetic form (velocity) and flow enthalpy (pressure/thermal content). An **isentropic flow** (ideal, no losses) through a nozzle or diffuser conserves the fluid's *stagnation conditions*: the stagnation (or total) enthalpy remains constant, which means any drop in static enthalpy directly converts to kinetic energy (and vice versa). This is why we use the **steady-flow energy equation** with only kinetic and enthalpy terms to analyze nozzles and diffusers. Keep in mind the behavior flips for supersonic flows (Mach > 1): a diverging section acts as a nozzle at Mach > 1, while a converging section acts as a diffuser – but for the FE exam, you mostly need the *qualitative understanding* of subsonic vs. supersonic trends and the basic energy relation.

Exam Handbook Search Cues (Not affiliated with or endorsed by NCEES): *nozzle; diffuser; isentropic flow; stagnation pressure; stagnation temperature*

Equation Passport: Nozzle/Diffuser Energy Equation – relates fluid enthalpy change to velocity change when flow area changes (no heat or work exchange). In an ideal nozzle or diffuser (adiabatic, no shaft work, negligible elevation change), the **steady-flow energy equation** simplifies to:

$$h_i + \frac{V_i^2}{2} = h_e + \frac{V_e^2}{2}.$$

- h_i – inlet specific enthalpy of the fluid (J/kg)
- h_e – exit specific enthalpy (J/kg)
- V_i – fluid velocity at inlet (m/s)
- V_e – fluid velocity at exit (m/s)

Assumptions and Scope: Steady-state, single-stream flow with **no heat transfer** (adiabatic) and **no work** done. Potential energy changes (due to elevation) are negligible. This equation assumes no losses (ideal **isentropic** behavior), so it preserves **stagnation enthalpy** (total energy per unit mass). Applicable to gases and liquids; for compressible flows, use property data for enthalpy. (If flow is *incompressible*, enthalpy change can be related to pressure via $\Delta P = \rho\,\Delta(V^2/2)$ akin to Bernoulli's equation footnote.)

Limit Tests (sanity checks): If the fluid is brought to rest in an ideal diffuser ($V_e \to 0$), then $h_e = h_i + V_i^2/2$. This means the exit static enthalpy is higher by the kinetic energy of inlet flow – consistent with converting velocity into internal energy (a rise in fluid pressure/temperature at stagnation). If instead the fluid is accelerated from rest through a nozzle ($V_i = 0$), then $V_e = \sqrt{2\,(h_i - h_e)}$, indicating the drop in enthalpy converts into kinetic energy. These limits reflect the definitions of **stagnation conditions**: *stagnation enthalpy* $h_0 = h + V^2/2$ remains constant.

Use vs. Sibling Equations: Use this energy equation for flow devices when **compressibility or gas properties are involved**, or when you have enthalpy values from tables. It's essentially the compressible-flow version of Bernoulli's equation. *Do not* confuse it with the incompressible Bernoulli equation (which uses pressure instead of enthalpy); Bernoulli is a special case for liquids or low-speed flows where density is constant. For air/gas nozzles at significant velocity, stick to the enthalpy form (or the Mach-number isentropic formulas) provided in the exam references.

Common Exam Traps:

- **Unit mix-ups:** Enthalpy is often given in kJ/kg in property tables, while $\frac{V^2}{2}$ yields J/kg (since $1\ \mathrm{J/kg} = 1\ \mathrm{m^2/s^2}$). Be careful to convert units if necessary (e.g. $20\ \mathrm{kJ/kg} = 20{,}000\ \mathrm{J/kg}$) so that the kinetic term and enthalpy are in the same units before adding or comparing them.

- **Neglecting one velocity term:** If a problem statement says the inlet or exit velocity is "negligible," you can drop that $V^2/2$ term. But if not explicitly negligible, **don't ignore velocity** – both nozzle and diffuser problems often hinge on that kinetic energy term.

- **Sign confusion:** Make sure to keep track of which side is inlet vs. exit. The equation is symmetric in form, but conceptually h_i will be higher than h_e in a nozzle (enthalpy drops as fluid speeds up), whereas h_e is higher in a diffuser (enthalpy rises as fluid slows down). If you accidentally swap i and e, you might get an unphysical negative value under the square root for velocity.

- **Assuming isentropic when not:** Real nozzles/diffusers have efficiency less than 100%. If the problem gives a nozzle efficiency (η), you must modify the ideal result. For example, actual exit velocity will be lower than ideal: $V_{e,\mathrm{actual}} = \sqrt{\eta_{\mathrm{nozzle}}\left(V_{e,\mathrm{ideal}}^2\right)}$. The exam may provide efficiency or state "assuming no losses" (which implies η = 100%). Read carefully.

Footnotes:

- *Enthalpy vs. Pressure:* In an ideal gas, h relates to temperature, and pressure drops correspond to enthalpy drops in isentropic flow. If needed, you can find h_i and h_e from temperature or steam tables.

In incompressible flow (liquid water through a nozzle), you might not have h readily; instead use Bernoulli's $P + \frac{1}{2}\rho V^2$ relation (which is analogous: P plays the role of h since $\Delta h \approx \frac{\Delta P}{\rho}$ for liquids footnote).

- *Stagnation Pressure:* While stagnation *enthalpy* stays constant in an ideal nozzle/diffuser, stagnation **pressure** stays constant only if the process is truly reversible (no friction). In a real nozzle, friction causes stagnation pressure to drop, but the exam typically assumes ideal or provides an efficiency to account for losses. If a problem asks for stagnation pressure, use isentropic relations or given data carefully, and remember stagnation pressure is higher than static pressure in a fast-moving flow.

- *Subsonic vs Supersonic:* For subsonic flows (Ma < 1), a **converging** nozzle accelerates flow; a **diverging** diffuser decelerates it. For supersonic flows (Ma > 1), the roles reverse beyond the throat: you need a **diverging** section to further accelerate to supersonic speeds (hence the converging-diverging rocket nozzles), and a **converging** section will decelerate supersonic flow (normal shock or diffuser action). The exam might include a conceptual question on this trend, so remember: *area up, velocity down* (subsonic) vs. *area up, velocity up* (supersonic).

- *When to use Mach relations:* If a problem gives Mach number or asks about it, the handbook provides isentropic flow formulas (ratios like $P_0/P = (1 + \frac{k-1}{2}Ma^2)^{k/(k-1)}$). Those are derived from the energy equation and ideal gas law. You can find those in the exam reference if needed by searching "isentropic flow" or "Mach." Use them if you specifically need pressure or temperature ratios for a given Mach (e.g. in a compressible nozzle flow question).

Explanation & Analysis: A nozzle or diffuser essentially converts energy between pressure and velocity. The **above equation** is a statement of energy conservation for a flowing fluid: the sum of *static enthalpy* (h, energy due to molecular motion and phase) and *kinetic energy per unit mass* ($V^2/2$) remains constant from inlet to outlet *if no energy is added or removed*. In practical terms, when a gas expands through a nozzle, its pressure and temperature drop (decrease in h) while its velocity increases (increase in $V^2/2$). Conversely, in a diffuser, the gas slows down ($V^2/2$ decreases) and that kinetic energy is converted into an enthalpy increase – raising the fluid's pressure (and temperature) as it exits. This trade-off is quantified by the equation.

Let's parse the terms: h_i and h_e represent fluid enthalpy at inlet and exit. For a gas, enthalpy is linked to temperature (for example, $h = c_p\ T$ for ideal gases with constant c_p). V_i and V_e are the flow speeds. The term $V^2/2$ comes from kinetic energy formula per unit mass. All quantities are typically in SI units (J/kg for enthalpy, m/s for velocity). If you plug numbers into this equation, ensure consistency: **convert enthalpies to J/kg** if they're given in kJ/kg, since $1\ \text{kJ/kg} = 1000\ \text{J/kg}$, and a velocity of 100 m/s corresponds to $100^2/2 = 5000\ \text{J/kg}$. It's easy to see how a fluid moving at several hundred m/s carries kinetic energy comparable to tens of kJ/kg of enthalpy.

On the exam, nozzle/diffuser problems might give you inlet conditions (say, pressure, temperature, and velocity) and ask for an exit velocity or pressure. Often you'll combine this energy equation with the **continuity equation** (mass flow continuity: $\rho_i\ A_i\ V_i = \rho_e\ A_e\ V_e$) and perhaps the ideal gas law to find unknowns. A common archetype: *"Air at 500 kPa and 300°C enters a nozzle at 20 m/s and expands to 100 kPa isentropically. Find the exit velocity."* To solve, you'd use the isentropic relations or table to find exit enthalpy at 100 kPa (since isentropic implies a known relationship between state 1 and state 2, or direct enthalpy from an isentropic process), then apply $h_i + V_i^2/2 = h_e + V_e^2/2$ to get V_e. If instead it were a diffuser problem, you might be given exit velocity ~0 (stagnation) and asked to find how much the pressure rises (often using isentropic pressure ratio formulas). Keep an eye out for keywords like "neglect losses" (means use this ideal equation) or "efficiency" (means the process isn't ideal, and you'll adjust the result accordingly, e.g. multiply kinetic energy change by efficiency).

In summary, **nozzles and diffusers** test your understanding of energy conversion in fluids. Use the energy equation to relate velocity and enthalpy changes, remember how area changes affect subsonic vs. supersonic flows qualitatively, and pay attention to units and efficiency factors. Practicing a few examples will make these relationships second nature, so you won't be thrown off by the quick algebra or unit conversions on exam day.

K11.T05.S02 – Turbines, Pumps, and Compressors

Principle Introduction: *Turbines*, *pumps*, and *compressors* are work-exchange devices – they either produce work or consume it. All three are typically analyzed as **steady-flow adiabatic** devices (no significant heat transfer during the process, so energy change is mainly between fluid enthalpy and work). In a **turbine**, high-pressure fluid expands and *does work on a rotating shaft*, resulting in a drop in fluid enthalpy; the shaft work output can drive a generator or other machinery. In contrast, **pumps** and **compressors** consume work input to raise the fluid's pressure (or head/enthalpy): a pump typically refers to liquid-handling devices (incompressible flow), whereas a compressor refers to gases. Velocity changes through these machines are often small enough to neglect in energy calculations (flow speeds inside a pump, for instance, don't change the fluid's kinetic energy drastically compared to enthalpy changes, and any small kinetic terms can often be ignored). The key performance metric for these components is their **isentropic efficiency** (η): a comparison of the actual machine performance to an ideal, reversible (isentropic) version of the same process. The ideal turbine would produce the maximum possible work (fluid drops to a lower enthalpy), and the ideal pump/compressor would consume the minimum work required (fluid reaches the desired pressure with the smallest enthalpy increase). Understanding the energy balance and efficiency definitions for these devices lets you solve exam problems involving work and power, outlet states, or required input power given an efficiency.

Exam Handbook Search Cues (Not affiliated with or endorsed by NCEES): *turbine work; pump efficiency; compressor efficiency; isentropic; enthalpy drop; enthalpy rise*

Equation Passport: Isentropic Efficiency of Turbines and Pumps/Compressors – measures how closely a real machine approaches ideal isentropic performance. These efficiencies are defined by comparing the actual enthalpy change to the ideal enthalpy change for the same pressure difference:

- **Turbine Efficiency,** $\eta_{\text{turbine}} = \frac{h_i - h_{e,\text{actual}}}{h_i - h_{e,s}}$ – ratio of actual work output to ideal isentropic work output.
- **Pump/Compressor Efficiency,** $\eta_{\text{comp/pump}} = \frac{h_{e,s} - h_i}{h_{e,\text{actual}} - h_i}$ – ratio of ideal isentropic work input (minimal required) to actual work input.

Here h_i is the fluid enthalpy at inlet. $h_{e,\text{actual}}$ is the actual exit enthalpy of the fluid from the device, and $h_{e,s}$ is the exit enthalpy **if** the device operated isentropically (ideal). All enthalpies are on a per unit mass basis (J/kg). Each efficiency η is a dimensionless fraction (often expressed as a percentage).

Assumptions and Scope: These definitions assume the device processes the fluid between the **same inlet and exit pressure** whether it's real or ideal. For turbines: the inlet state is given and the exit pressure is fixed (often by the downstream environment) – $h_{e,s}$ is found by an isentropic expansion to that pressure. For compressors/pumps: the outlet pressure is the target and $h_{e,s}$ comes from an isentropic compression to that pressure. All processes are adiabatic; we typically neglect changes in kinetic and potential energy, so the energy change is accounted for mainly by h and work. Also, the working fluid is the same for actual vs. ideal cases (so we can compare enthalpies meaningfully) and no mass is added or removed (single-stream flow). These efficiency formulas are within the FE exam scope for both liquids and gases – note that for liquids, enthalpy changes can be related to pressure via $\Delta h \approx v\,\Delta P$ footnote.

Limit Tests: If the machine were **ideal (reversible)**, then $h_{e,\text{actual}} = h_{e,s}$ and $\eta = 1.0$ (100% efficiency). This is the best-case scenario: turbine extracts the maximum energy, pump/compressor wastes no extra work. On the other extreme, if a turbine had huge internal losses, $h_{e,\text{actual}}$ might be nearly equal to h_i (meaning it produced almost no work output) so $\eta \to 0$. For a terribly inefficient pump/compressor, $h_{e,\text{actual}}$ would be much higher than $h_{e,s}$ (lots of wasted input energy heating the fluid), driving η toward 0. In reality, well-designed turbines often have η in the 80–90% range, and good pumps/compressors might be 70–85% efficient. Efficiencies *over 100%* are impossible – if you compute one, you likely reversed the numerator and denominator or used wrong enthalpy values.

Use vs. Sibling Equations: Use these efficiency formulas whenever a problem involves a **non-ideal turbine or compressor**. For an **ideal (isentropic) machine**, you set $\eta = 1$ and the energy change is simply $h_i - h_e$ from the isentropic process (which you might get from tables or isentropic relations). If instead you are given or asked for **actual** performance and an efficiency, use these to find the missing enthalpy. For example, to find actual turbine exit enthalpy given η_{turbine}, rearrange $\eta = \frac{h_i - h_{e,\text{act}}}{h_i - h_{e,s}}$ to solve for $h_{e,\text{act}}$. Similarly, for a pump, given η you can find actual exit enthalpy: $h_{e,\text{act}} = h_i + \frac{h_{e,s} - h_i}{\eta}$. **Do not** use these formulas for devices like throttling valves (where no work is involved) or situations with significant heat transfer – they are specifically for adiabatic work-producing or work-consuming devices. Also, don't confuse isentropic efficiency with thermal efficiency of a cycle; efficiency here is just comparing ideal vs actual enthalpy change for one component.

Common Exam Traps:

- **Mixing up formulas:** It's easy to confuse the turbine and compressor efficiency definitions. Remember: for turbines (work output devices), efficiency is actual work *divided by* ideal work. For pumps/compressors (work input devices), efficiency is ideal work (min required) *divided by* actual work. Writing the units can help: a turbine $\eta = \frac{\text{J/kg actual out}}{\text{J/kg ideal out}}$, while a compressor $\eta = \frac{\text{J/kg ideal in}}{\text{J/kg actual in}}$. Another way: **turbine η uses h drop, pump η uses h rise** in the numerator. If you accidentally invert these ratios, you might get an answer >100% or just incorrect.

- **Sign convention mistakes:** In the energy balance, turbine work output $w_{\text{out}} = h_i - h_{e,\text{act}}$ (this will be a positive number if $h_i > h_e$). Pump work input $w_{\text{in}} = h_{e,\text{act}} - h_i$ (positive if $h_e > h_i$). The efficiency formulas essentially compare those w values to their ideal counterparts $w_{\text{ideal}} = h_i - h_{e,s}$ (turbine) or $h_{e,s} - h_i$ (pump). Stick to the enthalpy differences as given; don't introduce extra negative signs.

- **Wrong reference states:** $h_{e,s}$ is not the same as $h_{e,\text{act}}$ – it must be determined by an *isentropic* process. On an exam, you might use steam tables or isentropic relations (like Pv^k for gases or $s_{\text{in}} = s_{\text{out}}$ to find state) to get $h_{e,s}$. Using the actual exit state in place of the ideal one (or vice versa) will throw off your efficiency. Read the problem: if it says "isentropic compressor outlet temperature," that corresponds to $h_{e,s}$, not the actual outlet enthalpy.

- **Units and basis:** Ensure you work per unit mass unless instructed otherwise. These ηformulas are per unit mass energy changes, which is typically how exam data is given (e.g. enthalpy in kJ/kg). If a problem gives total power and mass flow, you might need to convert by $\dot{W}_{\text{actual}} = \dot{m}\,\Delta h$, etc. Efficiency can also be applied to power directly using the same ratio since mass flow cancels, but always be clear whether you're dealing with per kg or total.

- **Pump specific case:** For liquids, an isentropic process at constant temperature is a good approximation, so you might compute $h_{e,s} - h_i \approx v\,(P_e - P_i)$ (with v = specific volume, assumed roughly constant). The handbook even gives *for pump only:* $h_{e,s} - h_i = v_i\,(P_e - P_i)$. This is handy if you don't have tables for the liquid; but if the exam gives you properties or a bulk modulus, stick with provided data. A trap is to blindly use $v\Delta P$ without checking units (if P is in Pa and v in m³/kg, the result is J/kg which is fine). If P is given in, say, kPa, convert to Pa in that formula or convert the result to kJ/kg appropriately.

Footnotes:

- *Energy Balance:* The fundamental energy balance for these components (from the first law) is $h_i + \frac{V_i^2}{2} = h_e + \frac{V_e^2}{2} + w_{\text{out}}$ for a turbine (work output positive) or $h_i + w_{\text{in}} = h_e$ for a pump/compressor (work input positive), neglecting heat and assuming negligible kinetic change.

In simplified form: **Turbine:** $w_{\text{out}} = h_i - h_e$; **Compressor:** $w_{\text{in}} = h_e - h_i$. These are *ideal* work values per unit mass if the process is adiabatic. For actual devices, h_e is different (higher for compressor, lower for turbine) due to irreversibilities, which is exactly what efficiency captures.

- *Pump vs Compressor:* The distinction is mostly the phase of the fluid. Pumps handle liquids (often nearly incompressible), so equations like $w \approx v\,\Delta P$ apply, and temperature rise in a pump is usually small. Compressors handle gases, so temperature and enthalpy rise significantly and you may need to use Pv^k or T relations or property tables. The FE exam may use the term "pump" for liquid and "compressor" for gas, but the efficiency formula is essentially the same form for both (and often given together). Sometimes "fan" or "blower" is used for low-pressure gas compressors, but efficiency concept still holds

- *Multiple stages:* If a question involves a multi-stage compressor with intercooling, etc., each stage could have its own efficiency. Usually, though, FE problems keep it to a single stage. If they do multi-stage, it might be about overall work minimized by

intercooling, which involves thermodynamics of cycles – that's beyond just this component efficiency formula. So focus on applying single-stage efficiency unless explicitly asked otherwise.

Explanation & Analysis:

For these machines, it's crucial to grasp **what the enthalpy change represents**: it ties directly to work. In a turbine, the fluid's enthalpy drop $h_i - h_e$ is converted to output work (per unit mass). In a pump or compressor, the enthalpy rise $h_e - h_i$ comes from input work. If everything were perfect (isentropic), all that enthalpy change would go purely into work exchange with no losses. But real devices have friction, turbulence, and other irreversibilities that waste some of the energy (often manifesting as unwanted fluid heating). The isentropic efficiency basically tells you **how large the losses are**.

Let's break down the **turbine efficiency** formula $\eta_{\text{turbine}} = \frac{h_i - h_{e,\text{act}}}{h_i - h_{e,s}}$. The numerator $h_i - h_{e,\text{act}}$ is the actual enthalpy drop of the fluid – which equals the actual work output per kg (assuming adiabatic). The denominator $h_i - h_{e,s}$ is the *maximum* possible enthalpy drop if the turbine were ideal and isentropic to the same exit pressure. So it's logical: the ratio is what fraction of the ideal work we actually got. If $\eta = 0.9$, that means we got 90% of the ideal work output; 10% was lost (the fluid didn't drop as far in enthalpy as it could have, meaning some energy stayed as internal energy, raising entropy instead of producing work).

For the **compressor/pump efficiency** $\eta_{\text{comp}} = \frac{h_{e,s} - h_i}{h_{e,\text{act}} - h_i}$, now $h_{e,\text{act}} - h_i$ is the actual enthalpy increase (actual work input per kg). The ideal scenario would have a smaller enthalpy increase $h_{e,s} - h_i$ (since an ideal compressor can pressurize with less added energy by avoiding entropy increase). So this ratio is ideally less than 1. If $\eta = 0.8$ for a pump, the work input is 1/0.8 = 1.25 times the ideal; i.e. 25% extra energy was needed due to inefficiency (often appearing as a slight temperature rise in the liquid).

When solving problems, a common approach is: 1. **Find the ideal outcome** first – either using isentropic relations or property tables. For example, if a steam turbine expands from 8 MPa, 500°C to 0.1 MPa, first determine the isentropic enthalpy at 0.1 MPa (by assuming entropy in = entropy out, find $h_{e,s}$ from steam tables). 2. Then apply the efficiency formula to find the actual enthalpy $h_{e,\text{act}}$. In a turbine, $h_{e,\text{act}} = h_i - \eta\left(h_i - h_{e,s}\right)$ (since actual drop is efficiency times ideal drop). In a compressor, $h_{e,\text{act}} = h_i + \frac{1}{\eta}\left(h_{e,s} - h_i\right)$ (since actual rise is bigger than ideal rise by factor $1/\eta$). 3. With that actual enthalpy, you can find other properties if needed (e.g., actual exit temperature or quality using tables, or the work required/output by multiplying the per-kg values by mass flow).

An example question might be: "Air at 300 K, 1 atm is compressed to 5 atm adiabatically. If the compressor efficiency is 85%, find the exit temperature." You'd find the isentropic exit temperature first (using $T_{e,s} = T_i\left(\frac{P_e}{P_i}\right)^{(k-1)/k}$ for air, or from the handbook data). That gives, say, $T_{e,s}$(ideal). Then recognize that with 85% efficiency, the actual $\Delta h$is larger:

$$\frac{\Delta h_{\text{ideal}}}{\Delta h_{\text{actual}}} = 0.85$$

For a perfect gas, $h = c_p T$, so you can translate enthalpy to temperature change. You'd compute $T_{e,\text{actual}} = T_i + \frac{1}{0.85}\left(T_{e,s} - T_i\right)$ to get the higher actual temperature (which accounts for extra entropy generation). That higher temperature is a telltale of inefficiency.

Finally, be aware of how power ties in: if the problem gives a mass flow $\dot{m}$, the power output of a turbine is $\dot{W}_{\text{out}} = \dot{m}\,(h_i - h_e)$, and the power input to a compressor is $\dot{W}_{\text{in}} = \dot{m}\,(h_e - h_i)$.

Efficiency can also be applied to power directly:

$$\eta_{\text{turbine}} = \frac{\dot{W}_{\text{out,actual}}}{\dot{W}_{\text{out,isentropic}}}$$

In many cases, though, working per unit mass is simpler and less error-prone; you can always multiply by $\dot{m}$at the end.

The main takeaways: use the energy balance to relate enthalpy and work, and apply isentropic efficiency to account for non-ideal behavior. On exam day, **identify which device you're dealing with** (turbine vs pump/compressor) and plug into the correct form of the efficiency formula. It's straightforward if you memorize one and remember the inversion for the other. With practice, you'll quickly recognize, for example, "turbine, given inlet/outlet conditions and an efficiency → find work output" or "pump, given pressure rise and efficiency → find required horsepower". These become plug-and-chug once you're comfortable with the enthalpy concepts.

K11.T05.S03 – Heat Exchangers

Principle Introduction: *Heat exchangers* transfer thermal energy between two flowing fluids without mixing them. They are ubiquitous in mechanical systems (radiators, condensers, evaporators, etc.) and can have different configurations. The two basic configurations are **parallel flow**, where the hot and cold streams enter at the same end and move in the same direction, and **counterflow**, where the streams enter from opposite ends and flow in opposite directions. There are also crossflow and more complex designs (like shell-and-tube with baffles), but the FE exam usually focuses on understanding the basic parallel vs. counterflow concept and applying energy balances. For a steady-state heat exchanger with no heat losses, **the heat released by the hot fluid is equal to the heat absorbed by the cold fluid**. This is essentially an application of the first law (conservation of energy) to two-stream systems, assuming the exchanger is well-insulated so no heat leaks to the environment. Types of heat exchangers also include phase-change devices: an **evaporator** (where the cold fluid gains heat and boils, as in a refrigeration cycle) or a **condenser** (where the hot fluid loses heat and condenses). These are really just special cases where one of the fluids undergoes a phase change, but the energy balance principle is the same. For FE exam purposes, you'll typically use the energy balance to find an unknown exit temperature or enthalpy, given the other fluid's data, or to compute the required heat transfer. It's a straightforward concept, but you must pay attention to direction of heat flow, proper identification of hot vs. cold streams, and unit consistency.

Exam Handbook Search Cues (Not affiliated with or endorsed by NCEES): *heat exchanger; energy balance; counterflow; parallel flow; evaporator; condenser*

Equation Passport: Heat Exchanger Energy Balance – equates the heat lost by the hotter stream to the heat gained by the colder stream (neglecting any heat loss to surroundings):

$$m_H \left(h_{H,in} - h_{H,out}\right) = m_C \left(h_{C,out} - h_{C,in}\right).$$

This is the *rate form* per unit time (with m as mass flow rate) if you're considering steady flow, but it equally applies on a per-kg basis to a given quantity of fluid in a batch process. Here the left side is the thermal energy the hot fluid gives up, and the right side is the thermal energy the cold fluid receives.

- m_H – mass flow rate of **hot** fluid (kg/s)
- $h_{H,in}$ – specific enthalpy of hot fluid at inlet (J/kg)
- $h_{H,out}$ – specific enthalpy of hot fluid at outlet
- m_C – mass flow rate of **cold** fluid (kg/s)
- $h_{C,in}$ – specific enthalpy of cold fluid at inlet
- $h_{C,out}$ – specific enthalpy of cold fluid at outlet

For cases with no phase change, you can expand each h change as $c_p \ \Delta \ T$ (assuming constant specific heat): $m_H \ c_{p,H}\left(T_{H,in} - T_{H,out}\right) = m_C \ c_{p,C}\left(T_{C,out} - T_{C,in}\right)$. If one side *does* change phase (like condensing or evaporating), it's safer to use enthalpies directly (including latent heat effects) from property data.

Assumptions and Scope: Steady-state operation with **no net heat loss** to the environment (the exchanger ideally only exchanges heat internally). No work is done (heat exchangers don't have moving parts doing work on the fluid; any fluid pressure drops due to friction are usually neglected in the energy balance). The fluids remain separate (no mixing of mass between them), so we treat each side with its own mass flow and enthalpy values. Changes in kinetic and potential energy are assumed negligible: although the fluids' speed and elevation may vary slightly through the exchanger, these effects are small compared with the heat transfer, so the $V^2/2$and $g\Delta z$ terms are ignored. The equation above is essentially a statement of the first law for two-flow systems under those assumptions. The FE exam expects you to know this basic relationship; detailed design equations (like log mean temperature difference, LMTD, or effectiveness-NTU methods) might be referenced in the handbook, but you'd only use those if a problem specifically provides data for it – typically, a straightforward energy balance is enough for exam problems involving heat exchangers.

Limit Tests: If the two fluids have the **same mass flow and specific heat** (and no phase change), the equation simplifies and you'd get $T_{H,in} - T_{H,out} = T_{C,out} - T_{C,in}$ – equal temperature magnitude changes (one cools, one warms by the same amount). If one fluid has a much larger heat capacity rate ($m \cdot c_p$) than the other (e.g., a huge flow of cooling water vs a small flow of hot oil), the large-capacity fluid will experience a very small temperature change while the small-capacity fluid changes a lot. The energy transferred Q is the same for both, but the temperature change splits inversely with heat capacities. Another check: if *no heat is transferred* (which is trivial), then $h_{H,in} = h_{H,out}$ and $h_{C,out} = h_{C,in}$, so both fluids stay at their initial states (makes sense). Also, note that neither side can drop below the other's outlet temperature in a parallel flow exchanger; in counterflow, the cold fluid can approach the hot fluid's inlet temperature as an upper limit. These are qualitative sanity checks to make sure your results don't violate the second law (heat can't spontaneously flow the wrong way or overshoot equilibrium).

Use vs. Related Equations: Use this basic balance whenever you have a two-fluid heat exchange with no losses. It's often the only equation you need to solve for an unknown exit temperature or enthalpy, given the other stream's data. If the problem provides a heat transfer coefficient U and area A and asks for something like "find the length of heat exchanger" or "temperature change given U and area," then you might use the **heat transfer equations** (like $Q = UA \ \Delta \ T_{\mathrm{LM}}$ with log-mean temperature difference). However, such problems are more rare in FE Mechanical – they belong partly to Heat Transfer subject. Typically, mechanical FE problems stay higher-level: use the energy conservation to find temperatures or heat rates. Also remember, if only one side of a heat exchanger is considered (like just an evaporator coil or a condenser), you might apply a simpler formula: $Q = m \ (h_{\mathrm{out}} - h_{\mathrm{in}})$ for that stream, but implicitly the other side is absorbing/rejecting that same Q. The provided handbook equations list both the single-stream energy balance ($h_i + q = h_e$ for one side) and the two-stream balance (as above). Use the form that matches the data you have – if you're dealing with both fluids, set the heats equal; if you only focus on one fluid's change, you can compute Q from one side and know it's the same for the other.

Common Exam Traps:

- **Mixing up hot vs. cold terms:** A very frequent mistake is to misidentify which fluid is losing heat and which is gaining. Write it out conceptually first: "hot fluid goes from 200°C to 100°C (loses heat), cold fluid goes from 20°C to 50°C (gains heat)". Then set up $m_H \ c_p \ \left(T_{H,in} - T_{H,out}\right) = m_C \ c_p \ \left(T_{C,out} - T_{C,in}\right)$. If you accidentally swap in/out on one side, you could end up with a negative number or an incorrect result. The left side of the equation above is inherently positive since $T_{H,in} > T_{H,out}$ for cooling hot fluid, and the right side is positive since $T_{C,out} > T_{C,in}$ for heating cold fluid. If your algebra yields a negative temperature change, double-check the setup.

- **Unit consistency:** Ensure mass flow rates and c_p units match. For instance, if m is given in kg/min, convert to kg/s before using SI units for c_p (J/kg·K). Or convert c_p to kJ/kg·K to use with kg/min, but it's safer to stick to base SI. Also, if one side is a **phase change**, h_{in} and h_{out} come from tables typically in kJ/kg – keep everything in kJ or J consistently.

- **Neglecting losses vs. given efficiency:** The problem statement might say "neglect any heat losses to the surroundings," which is your cue to use this full exchange equation. If instead a problem said the heat exchanger has, say, 80% effectiveness or some heat loss, you'd have to adjust the approach (maybe not all heat from the hot goes into the cold). However, the FE exam usually doesn't delve into heat exchanger effectiveness unless it's a conceptual question – they stick to ideal energy balance or straightforward U·A calculations provided you the formula.

- **Not recognizing phase change:** If, for example, the "cold" fluid is water that boils into steam in the exchanger (making it an evaporator), the temperature might remain at 100°C during the process (if at 1 atm) even as it gains heat. Using $m \ c_p \ \Delta T$ would give zero because $\Delta T = 0$ for the phase change, which is wrong approach. Instead, use enthalpy of vaporization: $Q = m \ \Delta \ h_{\mathrm{vap}}$. So always check if the inlet/outlet state hints at phase change (liquid water in, steam out, etc.) and use enthalpy values from steam tables or refrigerant data. The energy balance still holds, just that one side's $\Delta \ T$ is zero while $\Delta \ h$ is large.

Footnotes:

- *Counterflow vs. Parallel flow:* These terms might come up in conceptual parts of a question. **Counterflow** exchangers are

generally more efficient (can achieve a larger overall temperature change) because the temperature difference between the two fluids stays more nearly uniform along the length. **Parallel flow** has the fluids coming to a more quickly reached equilibrium, limiting the cold side's max temperature to somewhat below the hot side's inlet temperature. If the exam asks which configuration yields a higher outlet temperature for the cold fluid given the same inlet conditions and size, the answer is counterflow. However, you typically won't need to calculate differently for energy balance – the equation $m_H\ (h_{H,in} - h_{H,out}) = m_C\ (h_{C,out} - h_{C,in})$ doesn't depend on flow arrangement. The difference might appear if using heat transfer correlations or LMTD (log mean temperature difference formula: $\Delta\ T_{\text{lm}} = \frac{\Delta\ T_1 - \Delta\ T_2}{\ln(\Delta\ T_1/\Delta\ T_2)}$, which yields a larger mean ΔT for counterflow). But unless a problem specifically delves into calculating required area or something with LMTD given both configurations, you mostly need the qualitative understanding of counter vs parallel.

- *Heat exchanger types:* Besides parallel and counter, note **crossflow** (fluids perpendicular) is common (car radiators, air conditioning coils), and **shell-and-tube** exchangers often approximate counterflow or crossflow. **Evaporators and condensers** (like in power plants or HVAC) often operate with one fluid changing phase at essentially constant temperature on one side, which gives a different temperature profile. The exam might include the terms evaporator or condenser, but treat them just as heat exchangers where one side's temperature remains flat (and a large h change occurs). If a question references an evaporator or condenser, remember: evaporator = adds heat to a fluid to vaporize it (so it's the cold fluid picking up heat), condenser = removes heat to liquefy a vapor (hot fluid releasing heat).

- *Energy balance extension:* If there are losses, you could introduce an efficiency like

$$\text{Effectiveness} = \frac{\text{actual heat transfer}}{\text{max possible heat transfer}}$$

but that's more detail than typically needed. Most FE problems assume well-insulated (no loss) unless explicitly stating otherwise. If they do give a weird scenario like "10% of heat is lost to surroundings," you'd simply say $Q_{\text{cold}} = 0.9\ Q_{\text{hot}}$ instead of equal, and adjust accordingly.

Explanation & Analysis: The heat exchanger energy balance is arguably the simplest equation in thermodynamics: it's just conservation of energy applied to two fluids exchanging heat. To use it effectively, first **identify which fluid is hot and which is cold**. The hot fluid will experience a drop in enthalpy (cooling down), and the cold fluid will experience a rise in enthalpy (warming up). Write down what you know: e.g., "Hot oil enters at 120°C and leaves at 80°C, cold water enters at 20°C and leaves at ___ °C, mass flow rates given." Next, convert all temperatures to either °C or K consistently when computing ΔT (for differences, Celsius and Kelvin increments are identical, but if using in absolute formulas stick to K). Calculate the change in enthalpy for one fluid and set it equal to the other.

If no phase change and you have specific heats, you can do: $Q = m_H\ c_{p,H}(T_{H,in} - T_{H,out})$. That gives the rate of heat loss by the hot side (in kW if you use kg/s and kJ/kg·K). Set that equal to $m_C\ c_{p,C}(T_{C,out} - T_{C,in})$ to find the cold fluid's temperature change or missing value. If one side involves phase change, replace $c_p\ \Delta T$ with the enthalpy difference from phase change. For example, if steam condenses from x% quality to saturated liquid, use $\Delta h = h_{\text{liquid}} - h_{\text{vapor at inlet quality}}$ (which will be negative, indicating heat release). But it might be easier: if condensing fully from vapor to liquid at constant pressure, $Q = m\ \ h_{\text{lv}}$ (mass times latent heat). Then equate that to $m\ C\ c_p\ (T_{C,out} - T_{C,in})$ on the other side.

A practical **step-by-step** approach in an exam setting: 1. Write down $Q_{\text{hot}} = m_H\ (h_{H,in} - h_{H,out})$ (this will be a positive number representing heat given off by the hot stream). 2. Write down $Q_{\text{cold}} = m_C\ (h_{C,out} - h_{C,in})$ (heat absorbed by the cold stream). 3. Set $Q_{\text{hot}} = Q_{\text{cold}}$ (conservation of energy) and solve for the unknown. There will usually be just one unknown (e.g., one of the outlet temperatures, or a mass flow if that's what's asked). 4. If needed, convert that heat Q into other units or into a per-unit-mass basis. Sometimes the question might directly ask for Q (the heat transfer rate), which you can report after computing either side of the balance.

Example: *"In a counterflow heat exchanger, 2 kg/s of water is cooled from 90°C to 50°C by an oil stream that enters at 30°C and exits at 70°C. Assuming no losses, find the oil mass flow rate."* Here, identify: hot fluid = water (since it's being cooled from 90 to 50), cold fluid = oil (heated from 30 to 70). The water (hot) loses heat: $Q = 2\ \text{kg/s} \cdot c_{p,\text{water}} \cdot (90 - 50)$; take $c_{p,\text{water}} \approx 4.18\ \text{kJ/kg} \cdot \text{K}$. So $Q = 2 * 4.18 * 40 = 334.4\ \text{kJ/s} = 334.4\ \text{kW}$. That's the rate of heat loss by water. Set equal to heat gain by oil: $m_{\text{oil}} * c_{p,\text{oil}} * (70 - 30)$. If $c_{p,\text{oil}}$ were given, we'd solve $m_{\text{oil}} = \frac{334.4}{c_{p,\text{oil}} * 40}$. If $c_{p,\text{oil}} = 2\ \text{kJ/kg} \cdot \text{K}$ (just assume), then $m_{\text{oil}} = \frac{334.4}{2*40} = 4.18\ \text{kg/s}$. Notice here the oil needed is about double the water flow because its heat capacity per kg is about half. This simple calculation illustrates the direct use of the balance.

Another scenario: *"Steam at 100°C condenses to saturated liquid water at 100°C in a condenser at 1 atm, giving off heat to cooling water that enters at 20°C and leaves at 45°C. Find the required mass flow of cooling water per kg of steam."* The steam (hot fluid) releases $h_{\text{lv}} = 2256\ \text{kJ/kg}$ (latent heat at 100°C). The cold water picks up this heat: $m_C * 4.18\ \text{kJ/kgK} * (45 - 20) = 2256\ \text{kJ}$ (per 1 kg of steam). Solve $m_C = \frac{2256}{4.18*25} = 21.6$ kg of water per kg of steam. That's a typical energy balance with phase change – straightforward if you use enthalpy and specific heats correctly.

Finally, **parallel vs. counterflow** might be tested conceptually. For instance, a question might give inlet/outlet temperatures and ask which configuration is likely being used. If the cold outlet temperature is very close to the hot inlet temperature, that suggests a counterflow design (since parallel flow can't heat the cold fluid above the hot fluid's outlet temp). Or they could simply ask, "Which arrangement yields a larger mean temperature difference for the same inlet/outlet conditions?" – answer: counterflow. Be prepared to explain why: in counterflow, the hottest hot fluid meets the hottest cold fluid last, maintaining a driving temperature difference along the length; in parallel, the temperature difference at the cold end becomes small, limiting performance.

In summary, heat exchangers are about applying conservation of energy across two fluids. Keep track of what's hot, what's cold, use enthalpies or $m\ c_p\ \Delta T$ appropriately, and you'll handle these problems confidently. They tend to be plug-and-chug once set up correctly, so the main risk is a setup mix-up – double-check your identification of streams and temperature changes before crunching the numbers.

K11.T05.S04 – Refrigeration Components (Evaporator, Condenser, Expansion Valve)

Principle Introduction: In a vapor-compression refrigeration system (the most widely used refrigeration cycle, and the basis of many heat pumps and air conditioners), four main components work together to transfer heat from a low-temperature region to a higher-temperature region: the **evaporator**, **compressor**, **condenser**, and **expansion valve** (also known as a throttling valve). Each component's performance is crucial to the cycle's efficiency and capacity. Although the *compressor* is a big part of the refrigeration cycle, we covered compressors earlier in the turbomachinery section (Topic 5.2). Here, we focus on the **other three components**:

- **Evaporator:** A heat exchanger in which the refrigerant takes in heat from the space or fluid being cooled. It enters the evaporator at low pressure as a cold liquid–vapor mixture and leaves as a (mostly or fully) evaporated low-pressure vapor. In absorbing heat Q_L, the evaporator provides the cooling effect (think of it like the "cold coil" in a fridge or AC unit). Performance-wise, we typically assume the evaporator is a steady-flow device with no work (just like any heat exchanger); the key result is the refrigerant picks up latent heat of vaporization. The evaporator often operates isothermally (constant temperature) if the refrigerant is boiling at a constant pressure.

- **Condenser:** A heat exchanger in which the refrigerant rejects heat to the surroundings (or to a cooling medium such as outside air or water). The refrigerant enters the condenser as a hot, high-pressure vapor from the compressor and leaves as a high-pressure liquid after it condenses. The heat given off, Q_H, is dumped typically to the ambient environment. Again, no work is done in the condenser – it's an exothermic heat exchange process, often also isothermal while the refrigerant condenses at constant pressure.

- **Expansion Valve (Throttling Valve):** A flow restriction that dramatically drops the pressure of the refrigerant without extracting work. It's essentially a *constant-enthalpy (isenthalpic) expansion* process – meaning the refrigerant's enthalpy before and after the expansion valve is the same (ideal throttling has no heat, no work, but is highly irreversible). The sharp pressure drop makes some of the liquid refrigerant flash into vapor, producing a low-temperature liquid–vapor mixture at the evaporator inlet. The expansion valve is what creates the low-pressure, low-temperature condition needed for the refrigerant to absorb heat in the evaporator. Performance-wise, while it doesn't have an efficiency like a turbine (since it's not producing work), it's a necessary evil: it causes entropy to increase and is where a lot of inefficiency in the cycle occurs, but it's cheap and reliable compared to using a turbine for expansion.

In summary, **evaporator and condenser** are duals (one adds heat at low temp, the other removes heat at high temp), and the **expansion valve** is a simple but irreversible device that connects the high-pressure and low-pressure sides. Understanding these components helps in refrigeration cycle problems – e.g., computing heat absorbed, heat rejected, or analyzing the effect of a throttling process on refrigerant state. On the FE exam, you might be asked conceptually about what each component does, or to compute values like the Coefficient of Performance (COP) of a refrigeration cycle (which relates Q_L and compressor work), or maybe to find an exit temperature or quality after one of these components given data. Being clear on these components' roles and the basic processes (especially that the expansion is isenthalpic) will let you navigate such questions quickly.

Diagram Passport: Vapor-Compression Refrigeration Cycle – *Role:* illustrates how the evaporator, compressor, condenser, and expansion valve connect and what each does to the refrigerant. *Reading the diagram:* Follow the loop clockwise starting from the **Evaporator** (bottom). In the evaporator, the low-pressure refrigerant absorbs heat Q_L from the region being cooled (or from a secondary fluid) and leaves the evaporator as a vapor. Next, the **Compressor** (right side) takes in this vapor and does work W on it, boosting its pressure and temperature (now a high-pressure superheated vapor). The hot vapor then flows into the condenser, where it rejects heat Q_H to the surroundings (air or water) and cools and condenses into a high-pressure liquid. This liquid then goes through the **Expansion Valve** (left side), which throttles it down to a low-pressure mixture (cold refrigerant ready to absorb heat again in the evaporator). *Key points:* The cycle has a high-pressure side (from compressor outlet, through condenser, to expansion valve inlet) and a low-pressure side (from expansion valve outlet, through evaporator, to compressor inlet). The largest temperature difference is in the condenser (hot refrigerant vs ambient) and evaporator (cold refrigerant vs cooled space). The cycle repeats continuously in steady state.

How to interpret (exam-style): If a question provides properties at various points (often numbered 1–4 around the cycle), identify which component those points correspond to. For instance, "state 1" can be the evaporator outlet (low-pressure vapor entering the compressor), "state 2" the compressor outlet (high-pressure vapor), "state 3" the condenser outlet (high-pressure liquid), and "state 4" the expansion-valve outlet (a low-pressure liquid–vapor mixture entering the evaporator). Recognizing this mapping is crucial. Then you apply the appropriate process understanding: between 1 and 2 (compression), use isentropic efficiency if needed; between 2 and 3 (condensation), it's constant-pressure heat rejection (cooling the refrigerant); between 3 and 4 (expansion), apply $h_3 = h_4$ (constant enthalpy throttling); between 4 and 1 (evaporation), it's constant-pressure heat absorption (boiling). In calculations, you might use tables: e.g., find h_1 and h_4 for saturated or two-phase states, etc. The diagram helps keep track of these steps so you plug in correct values.

Common Misreads:

- Confusing the direction of heat flow: e.g., thinking the evaporator "releases" heat or the condenser "absorbs" heat. It's the opposite – evaporator takes in heat from the cooled space, condenser dumps heat out to environment. Remember: **evaporator = evaporation (endothermic), condenser = condensation (exothermic)**.

- Misidentifying high vs. low pressure sides: The compressor is the dividing line – before compression is low pressure, after is high. If you get that backwards, you might look up wrong refrigerant properties (e.g., thinking a fluid is high-pressure liquid when it's actually low-pressure saturated mixture). The diagram labels can remind you: evaporator & expansion valve are on low-pressure side; condenser & compressor on high-pressure side.

- Assuming the expansion valve is isentropic: It is **NOT** – entropy increases because it's a highly irreversible process. Isenthalpic (constant enthalpy) is the correct assumption. If you mistakenly treat it like a reversible expansion (like a turbine), you'll use the

wrong h_4 (you'd end up with a lower enthalpy than inlet, which is not what happens in a throttle). A throttle basically wastes the pressure energy without extracting work, so enthalpy stays the same and a lot of exergy is lost

- Ignoring quality after expansion: The mixture at evaporator inlet (state 4) is usually a two-phase mix (part liquid, part vapor). If a problem asks for the quality or temperature at evaporator inlet, you use $h_4 = h_3$ along with the low pressure to find quality (x) or T_{evap} (which equals saturation temp at that pressure). A common mistake is to assume it's all liquid or all vapor – it's neither, it's a mix. That mix ensures you have some liquid to evaporate and absorb heat in the evaporator. If you got an unphysical answer like quality >1 or <0, then something went wrong in calculations.

Footnotes:

- Coefficient of Performance (COP): Although not a "component," the efficiency of a refrigeration cycle is measured by COP. For a refrigerator (cooling mode), $\text{COP}_{\text{ref}} = \frac{Q_L}{W_{\text{in}}}$, where Q_L is heat absorbed in evaporator and W_{in} is compressor work. For a heat pump (heating mode), $\text{COP}_{\text{hp}} = \frac{Q_H}{W_{\text{in}}}$. The exam may ask for COP given some energies or require using the first law $Q_H = Q_L + W$ to find one if you know the others. COPs typically range above 1 (since you move more heat than the work you put in; e.g., a COP of 3 means 1 kW of work yields 3 kW of cooling). Just recall the definitions and that higher COP is better. Also note the Carnot COP limits: $\text{COP}_{\text{Carnot, ref}} = \frac{T_{\text{cold}}}{T_{\text{hot}} - T_{\text{cold}}}$, which might be used for theoretical max comparisons.

- *Evaporator/Condenser pressure:* In an ideal cycle, the evaporator and condenser each operate at constant pressure (the low and high pressure of the system). So the refrigerant's saturation temperature in the evaporator is fixed by the pressure (that's the cooling temperature), and similarly for condenser. If you see a pressure-enthalpy (P-h) diagram or T-s diagram in study materials, evaporator is a horizontal line at low pressure (boiling), condenser a horizontal line at high pressure (condensing). The compressor connects those pressures (vertical line on T-s if isentropic ideally), and expansion valve also connects (vertical line on P-h diagram since enthalpy constant). Understanding this can help eliminate wrong answers: e.g., if someone suggests the refrigerant temperature rises in the expansion valve, that's false – expansion drops temperature due to Joule-Thomson cooling (except some weird gases)

- *Real vs. ideal:* Real refrigeration components have inefficiencies: compressor has η (we covered), evaporator/condenser might have pressure drops or inefficiencies (less heat transfer than expected), and expansion valve is just a big loss (sometimes improved by using an "expander" but that's uncommon in standard refrigeration). For FE exam, unless specifically stated, assume ideal function: compressor is often treated as isentropic (or a given η if provided), evaporator/condenser as no pressure drop and complete heat transfer, expansion as isenthalpic. A question might ask, for instance, "what is the effect of an inefficient compressor on COP?" (answer: COP drops, because you need more work for same Q_L). Or "what if the evaporator isn't well insulated?" (then you lose cooling capacity because not all heat goes into refrigerant). But these are more conceptual.

Explanation & Analysis: The refrigeration cycle ties together the performance of all these components, but let's spotlight each:

- **Evaporator:** Functionally, it's identical to any heat exchanger – you could apply the energy balance $Q_L = m_{\text{ref}}(h_1 - h_4)$ where using typical state numbering, 4 is expansion valve outlet (evap inlet) and 1 is evap outlet (comp inlet). $h_1 > h_4$ because the refrigerant gained enthalpy from the environment. Practically, h_1 is the enthalpy of saturated vapor leaving the evaporator (if fully evaporated), and h_4 is enthalpy of the cold mix entering. The difference is the latent heat absorbed. If they ask "what happens in the evaporator?", the answer: liquid refrigerant evaporates by absorbing heat, providing cooling. If a numerical problem, you might have to find Q_L given mass flow or vice versa. For instance, if 0.1 kg/s of R-134a enters an evaporator at -10°C, 20% quality and leaves as vapor at -10°C, you'd find h_4 (at -10°C, x=0.2) and h_1 (at -10°C, x=1.0) from refrigerant tables, then $Q_L = \dot{m}(h_1 - h_4)$. That's the cooling provided.

- **Condenser:** Similar approach: $Q_H = \dot{m}(h_2 - h_3)$ where 2 is compressor outlet and 3 is condenser outlet. $h_2 > h_3$ (the refrigerant loses enthalpy as it condenses). The heat Q_H is dumped typically outside (like the warm air you feel blowing from an AC's outdoor unit). In many problems, you might not calculate Q_H unless asked for COP or something, but remember $Q_H = Q_L + W_{\text{comp}}$ by energy balance for the cycle as a whole. One trick: sometimes they give condenser cooling water info to find Q_H (like a heat exchanger problem embedded – e.g., cooling water enters condenser at one temp and leaves at another, find flow rate needed given Q_H). You'd use the same heat exchanger skill from subtopic 3.

- **Expansion Valve:** The big result is $h_3 = h_4$ (assuming ideal throttling, no heat/work). You often know state 3 from condenser (e.g., saturated liquid at some pressure), so you get h_3 from tables. Then you set $h_4 = h_3$. With h_4 and the low pressure (equal to evaporator pressure), you can determine the state at 4. Typically it's a two-phase mixture: you can find the quality x_4 using $h_4 = h_f + x_4 \; h_{fg}$ at evaporator pressure. That quality tells you how much of the refrigerant immediately evaporated upon throttling (and conversely, how much is still liquid to be evaporated in the coil). The temperature at state 4 will be the saturation temperature at evaporator pressure (which is the evaporator operating temp). The reason T drops is that as some liquid flashes to vapor, it absorbs latent heat from itself, cooling the mixture to the saturation temperature at the new lower pressure. Importantly, **throttling is irreversible** – entropy increases. But we don't need to calculate the entropy for most FE problems, just recognize that it's not isentropic. The exam might indirectly test that concept: e.g., "Which process in the refrigeration cycle is accompanied by a significant increase in entropy?" The answer: the expansion (throttle). Or they may ask, "What equation best represents the expansion valve process?" The answer would be "constant enthalpy" ($\Delta h = 0$).

Now, a typical FE question might give you a table of property data at four states and ask for COP, or ask which component corresponds to which change. For example: *"Refrigerant-134a enters the compressor as saturated vapor at -10°C and leaves at 50°C, 0.8 MPa. It then passes through a condenser and expansion valve. Determine the quality at evaporator inlet."* Approach: state 1 (-10°C sat vapor) get h_1; state 2 (after compressor 50°C, 0.8 MPa)

get h_2; state 3 (after condenser, likely 0.8 MPa liquid at maybe 30°C if cooled) get h_3 (sat liquid at 0.8 MPa); then state 4 after throttle, $h_4 = h_3$, pressure back to evaporator pressure (0.2 MPa corresponding to -10°C sat). Find quality x_4 from h_4 at that low pressure. This is a multi-step but straightforward application of component models: compressor (maybe use efficiency if given, but here not given so assume ideal isentropic to find 2's entropy =1's entropy then find T2 etc.), condenser (cool to liquid), expansion (h3=h4), evaporator (just realize 4->1 picks up heat). In a simpler scenario, they might just ask conceptually: "What is the purpose of the expansion valve in a refrigeration cycle?" Expected answer: "To drop the refrigerant pressure (and temperature) without doing work, producing a cold mixture that can absorb heat in the evaporator."

As another point, sometimes **evaporators and condensers** are referenced in the context of *HVAC (heating, ventilation, air conditioning)* problems. For instance, calculating cooling load or humidification, but that's more in the thermo/heat transfer realm. If the exam question drifts to HVAC, just recall evaporator = cooling coil, condenser = hot coil. But that's just context.

In summary, mastering these refrigeration components means:- Recognize each component's thermodynamic process (heat exchanger vs compressor vs throttle).- Apply the right relation (no heat/work for throttle → constant h; no work for evaporator/condenser → use heat balance; compression often adiabatic → use efficiency or isentropic relations).- Understand qualitatively the heat flows Q_L and Q_H and work W, and how they relate in the cycle ($Q_H = Q_L + W$).- Know definitions like COP and possibly Carnot limits.

Refrigeration questions are often multi-faceted, but if you break the cycle at the component level, it becomes a series of simpler problems. For the FE, you typically won't have to design a whole refrigeration system, but you should be comfortable analyzing one cycle's states or computing performance given a set of data. And always keep the big picture: the *evaporator makes things cold* by absorbing heat, the *condenser dumps heat out*, the *compressor is the energy input*, and the *expansion valve enables the low temperature* (at the cost of some efficiency). Keeping that story straight will guide you to the correct equations and avoid confusion between similar-sounding terms or processes.

Topic 06 - Power Cycles

Topic Introduction: Power cycles are thermodynamic loops that convert heat into useful work, forming the basis of engines and power plants. Mastering this topic is crucial for the FE Mechanical Exam, as questions often ask you to compute a cycle's **thermal efficiency**, compare different engine cycles, or identify process steps (e.g. isobaric vs isochoric heat addition). You'll encounter archetypal problems like finding the maximum possible efficiency between two temperature limits (hint: Carnot), determining the efficiency of an ideal Otto or Diesel engine given compression ratio, or recognizing how modifications like regeneration and reheat improve a steam cycle's performance. In short, this chapter arms you with the fundamental formulas and concepts to tackle any **power cycle** question on exam day with confidence.

K11.T06.S01 – Heat Engine Cycles & Thermal Efficiency

Principle Introduction:

- A **heat engine** is a **cyclic** device that takes in heat from a high-temperature source, converts part of it into **net work**, and discharges the rest to a low-temperature sink.

- **Thermal efficiency** (η) is the key performance metric of a power cycle – it tells you what fraction of the input heat is turned into work. Higher efficiency means less fuel wasted as unrecovered heat.

- Because of the second law of thermodynamics, a heat engine **cannot turn all of the input heat into work**; some heat must be rejected to the colder sink. Thus η is always less than 1 (or 100%).

- Maximizing efficiency involves reducing wasted heat Q_{out} – intuitively, you want the engine to reject as little heat as possible. The theoretical way to maximize η is to make the cycle **reversible** and operate it between the largest possible temperature difference (approaching the Carnot limit – see next subtopic).

Equation Passport – Thermal Efficiency of a Heat Engine

- **Name & Purpose: Thermal Efficiency** – measures the fraction of input thermal energy converted to net output work in a cyclic heat engine. It answers "How effectively does this cycle produce work from heat?"

- **Equation:** $\eta = \frac{W_{\text{out}}}{Q_{\text{in}}} = 1 - \frac{Q_{\text{out}}}{Q_{\text{in}}}$

- **Variables and Units:**

- W_{out} – net work output per cycle (Joules, or BTU in USCS). This is the useful work delivered by the engine.

- Q_{in} – heat absorbed from the hot reservoir per cycle (Joules). This is the energy input that you pay for (e.g. via fuel combustion or heat supply).

- Q_{out} – heat rejected to the cold reservoir per cycle (Joules). This is waste heat dumped, usually to ambient or a cooling medium. (All Q values are taken as positive magnitudes for this formula.)

- **Assumptions & Scope:**

- Applies to any **closed cycle heat engine** exchanging heat with two reservoirs (one hot, one cold). Based on the First Law: over a full cycle $Q_{\text{in}} = W_{\text{out}} + Q_{\text{out}}$, which leads to the given efficiency formula.
- All heats Q should be measured **in absolute terms** (energy transferred *into* the engine is Q_{in}, out of the engine is Q_{out}). Sign conventions (heat in positive, heat out negative) are already accounted for in the formula by the subtraction $1 - Q_{\text{out}}/Q_{\text{in}}$.

- Efficiency is a **dimensionless ratio** (often expressed as a percentage). A result like $\eta = 0.3$ means 30% efficiency.

- **Limit Tests (Sanity Checks):**

- If **no heat is wasted** ($Q_{\text{out}} \to 0$), then $\eta \to 1$ (100% efficiency). This is the idealized upper limit – in reality unreachable due to entropy generation (Carnot efficiency is the closest theoretical approach).

- If **no work is produced** ($W_{\text{out}} \to 0$), then $\eta = 0$ (0% efficiency). For example, an engine that just moves heat from hot to cold without outputting work has zero efficiency.

- Because $W_{\text{out}} = Q_{\text{in}} - Q_{\text{out}}$, the efficiency can also be seen as $1 - Q_{\text{out}}/Q_{\text{in}}$. If the engine wastes as much heat as it takes in ($Q_{\text{out}} = Q_{\text{in}}$), efficiency is 0 (all input heat is dumped, none converted to work).

- **Use vs. Sibling Equations:** Use this efficiency formula for any **power cycle (heat engine)** question. In contrast, **refrigerators and heat pumps** are not evaluated by efficiency but by **Coefficient of Performance (COP)**, since they move heat *opposite* to its natural direction. For example, a refrigerator's COP is $Q_{\text{out}}/W_{\text{in}}$ rather than W/Q. On the FE Exam, if the problem is about producing work from heat, stick with η (efficiency); if it's about moving heat with work input (cooling or heating), think COP instead.

- **Common Exam Traps:**

- **Mixing up Q_{in} and Q_{out}:** Remember Q_{in} is the heat *supplied* at the high temperature. Only use that in the denominator. A common mistake is to plug the heat rejected or the sum of heats into the wrong place. Keep the formula logical: useful output over costly input.

- **Unit consistency:** Ensure the work and heat are in the **same units** before forming the ratio. For instance, don't divide work in BTU by heat in J; convert one to the other or use consistent units from the start. Since it's a ratio, the units will cancel, but using mixed units will yield a meaningless number.

- **Reporting the answer:** Efficiency is often requested in percent. If your calculation gives $\eta = 0.35$, the exam might expect "35%". Be ready to convert between a fraction and percentage.

Exam Handbook Search Cues (Not affiliated with or endorsed by NCEES): *efficiency*, *thermal efficiency*, *heat engine*, *work output*, *heat input* (These terms will help you quickly find the efficiency formula in the exam reference if needed.)

Footnotes:

- *Efficiency is dimensionless.* You might see it as a pure ratio or a percentage. For clarity on the exam, use the format the question asks for (decimal or %).

- *Sign convention:* In typical convention, Q_{in} and W_{out} are positive for an engine (heat entering, work leaving). The formula $\eta = W_{\text{out}}/Q_{\text{in}}$ inherently assumes that convention. If a problem gives a **negative** heat value (indicating direction), it's safer to use magnitudes in the efficiency formula and infer the direction separately.

- *Second Law implications:* A η of 100% would violate the Kelvin–Planck statement of the Second Law (no cyclic process can convert heat entirely into work with no other effect). Thus, expect η values on real cycles to be well below 1.

Variations & Related Forms:

- **First-law form:** Sometimes you'll rearrange the basic formula using $W_{\text{out}} = Q_{\text{in}} - Q_{\text{out}}$ to $\eta = 1 - \frac{Q_{\text{out}}}{Q_{\text{in}}}$. This form emphasizes that inefficiency comes from the fraction of heat not converted to work. It's useful if you can easily find the rejected heat (for example, via energy balances or steam tables for a condenser).

- **Typical efficiency ranges:** Real heat engines have moderate efficiencies. e.g. A gasoline engine (Otto cycle) might have $\eta \approx 25\% - 35\%$, a Diesel engine $\approx 30\% - 45\%$, a simple Brayton gas turbine $\approx 20\% - 30\%$, and a steam Rankine power plant $\approx 30\% - 40\%$. These are far below 100% because of practical irreversibilities and fundamental limits. Such values give you a ballpark check – if you calculate an engine efficiency on the exam that's, say, 0.8 (80%) without it being a theoretical Carnot question, double-check; you likely misinterpreted something.

- **Maximizing efficiency:** To design for higher η, engineers raise the heat addition temperature or lower the heat rejection temperature (or both). This is why modern power plants use superheated steam and high-pressure boilers (raising T_{hot}) and efficient cooling towers or even cryogenic coolers (lowering T_{cold}). However, material limits and ambient conditions pose practical limits – which is exactly what the Carnot efficiency (next) encapsulates.

Special Notes – Calculator: Calculating a simple efficiency is straightforward on any FE-approved calculator: just perform the division W/Q or use the subtraction form. **Be mindful of using parentheses** if you compute $\eta = 1 - Q_{\text{out}}/Q_{\text{in}}$ in one line (e.g. type 1 - (Q_out ÷ Q_in) to ensure the division happens before subtracting from 1). Also, if dealing with large energy values, use the exponent or engineering notation features of your calculator to keep track of orders of magnitude.

Explanation & Analysis: Thermal efficiency η tells you how well an engine transforms heat into work. On the FE Exam, you'll use this formula whenever you're dealing with a **power cycle** – it's often the final step after computing Q_{in} and W_{out} from other data. The basic idea: an engine takes in heat Q_{in} at a high temperature (for example, fuel combustion in a cylinder or heat from a boiler), does some work, and dumps the rest Q_{out} to a cooler sink (like exhaust or a condenser). The efficiency is simply quantifying that ratio $W_{\text{out}}/Q_{\text{in}}$. A higher number means a more effective engine – you get more bang for your buck (or more joules of work per joule of heat input).

Let's break down the terms in $\eta = 1 - \frac{Q_{\text{out}}}{Q_{\text{in}}}$. The fraction $\frac{Q_{\text{out}}}{Q_{\text{in}}}$ is the portion of input heat that is **wasted** to the cold sink. Subtracting it from 1 means we're focusing on the **complement** – the portion turned into work. If an engine wastes 60% of the heat, its efficiency is $1 - 0.60 = 0.40$ (40% converted to work). By contrast, if it only wastes 30%, efficiency is 70%.

Physically, Q_{out} typically cannot be zero because the engine must dump entropy to the sink. That's why even the best-designed engines expel some heat. The Second Law essentially says there's a "tax" on heat-to-work conversion – you must always pay some heat to the cold reservoir. The **Carnot cycle**, coming up next, shows what the minimal "tax" is for given temperatures.

On exam day, a common pitfall is confusing what values to plug in: ensure you correctly identify the heat input (usually associated with the **high-temp heat source**) and the net work output. For instance, in a gas turbine problem, the heat input might be the fuel energy added in the combustor, and the net work is turbine work minus compressor work. Always apply the first law to find W_{out} if needed: if you know heat in and heat out, you can get work out by difference. Once you have W_{out} and Q_{in}, computing η is straightforward.

One more check: because efficiency is often given in percent, it's easy to misplace a decimal. If a question says an engine is 40% efficient and asks for work output given 500 J of heat input, remember to use $\eta = 0.40$ in calculation ($W = \eta\, Q_{\text{in}} = 0.40 \times 500 = 200$ J). If you mistakenly used 40 (thinking in percent without converting), you'd get an absurdly large work output. Keep an eye on units and scales.

In summary, thermal efficiency is your **go-to formula for any power cycle performance question**. It's conceptually simple – output over input – but it encapsulates a lot of physics. Every improvement or modification to a cycle (higher compression, better insulation, reheat, regeneration, etc.) ultimately aims to inch that ratio closer to 1, as the next subtopics will illustrate.

K11.T06.S02 – Carnot Cycle as Ideal Benchmark

Principle Introduction:

- The **Carnot cycle** is an idealized heat engine cycle that serves as the gold-standard benchmark for efficiency. It's a purely theoretical cycle composed of **reversible processes** – two isothermal processes (heat transfer at constant temperature) and two adiabatic (isentropic) processes.

- **Carnot efficiency** is the maximum possible efficiency any heat engine can achieve **operating between two given temperatures** T_H (hot reservoir) and T_L (cold reservoir). No real engine can exceed Carnot efficiency, and all practical cycles fall short of this limit due to irreversibilities.

- The formula for Carnot efficiency is elegantly simple and depends only on temperatures: higher hot-source temperature and lower cold-sink temperature drive efficiency up. This guides engineers: to improve efficiency, increase T_H or decrease T_L (within material and environmental limits).

- On the exam, Carnot cycle questions typically involve either computing the theoretical max efficiency given reservoir temperatures or conceptual comparisons (e.g. "Why can't this real engine exceed X% efficiency?" Answer: because Carnot limit is lower). It's often a quick plug-in of temperatures into the Carnot formula, but **make sure to use absolute temperatures** (Kelvin or Rankine).

- The Carnot cycle also underpins the **Coefficient of Performance** limits for refrigerators and heat pumps (reversed Carnot cycle), but in this topic we focus on its role as a heat engine.

Equation Passport – Carnot Efficiency

- **Name & Purpose: Carnot Efficiency** – the theoretical maximum fraction of heat converted to work by a reversible engine between a hot and cold reservoir. It tells us "Given T_H and T_L, what is the best efficiency any engine could possibly achieve?".

- **Equation:** $\eta_{\text{Carnot}} = 1 - \frac{T_L}{T_H}$

- **Variables and Units:**

- T_H – **Hot reservoir absolute temperature**. This is the temperature at which heat is supplied to the engine (in Kelvin for SI, or Rankine for USCS).

- T_L – **Cold reservoir absolute temperature**. The temperature at which waste heat is rejected (also in K or °R).

- η_{Carnot} – The Carnot efficiency (dimensionless, often expressed as a decimal or %). It is unitless since it's a ratio of temperatures (the Kelvin/Kelvin cancels out conceptually).

- **Assumptions & Scope:**

- The Carnot formula assumes an **ideal reversible cycle** operating between *two fixed-temperature reservoirs*. The engine absorbs heat isothermally at T_H and rejects heat isothermally at T_L. No other temperature levels of heat transfer are involved.

- All processes are **frictionless and quasi-static** (no entropy generation). In reality, no engine can be truly reversible, but Carnot sets the upper bound if you could eliminate all inefficiencies.

- T_H and T_L **must be in absolute scale**. This is critical: if you plug in 500°C and 20°C directly, you will get nonsense. Convert to Kelvin (773 K and 293 K, for example) before using the formula. The ratio T_L/T_H is only meaningful on an absolute scale where 0 means absolute zero.

- The formula yields the ideal **max efficiency**. Real engines have efficiencies $\eta_{\text{real}} = \eta_{\text{Carnot}} \times$ (some efficiency factor < 1). For instance, a well-designed real engine might reach 60% of Carnot's efficiency at best due to irreversibilities.

- **Limit Tests:**

- If $T_L \to 0$ (the cold sink approaches absolute zero), then $\eta_{\text{Carnot}} \to 1$ (100%). In theory, an engine dumping heat into a **0 K** reservoir could be perfectly efficient. Practically impossible, of course, since reaching 0 K is unachievable and would violate thermodynamics in other ways.

- If $T_H = T_L$, then $\eta_{\text{Carnot}} = 1 - 1 = 0$. This makes sense: if your heat source and sink are at the same temperature, there is no thermal gradient to drive heat flow or produce work – it's like trying to run a heat engine with no temperature difference, you can't extract any work.

- For a **small temperature difference** (say T_H just a bit above T_L), η_{Carnot} will be very low. This matches intuition: engines are very inefficient when the source isn't much hotter than the sink (not enough "thermodynamic pressure" to push energy into work).

- As T_H increases or T_L decreases, η_{Carnot} increases but with diminishing returns. For example, going from a 300 K sink to 290 K yields a bigger efficiency jump than the same 10 K drop when the sink is at 100 K, due to the ratio nature.

- **Use vs. Sibling Equations:** Use the Carnot formula *only* for ideal benchmark questions or to **check the theoretical limit**. If a problem gives you two reservoir temperatures and asks for maximum possible efficiency, this is your go-to equation. **Do not** apply $\eta = 1 - T_L/T_H$ blindly to real cycles that don't operate in a strictly Carnot manner (like Rankine, Brayton, etc., which involve non-isothermal heat addition). In those cases, the Carnot efficiency serves as a comparison, not an actual attained value. For example, you wouldn't plug the boiler and condenser temperatures of a Rankine cycle into Carnot's formula to get Rankine efficiency (that would overestimate, since Rankine adds heat over a range of temperatures, not one T_H). Instead, use Carnot as a yardstick: "this Rankine cycle's efficiency is 32%, while Carnot between the same extremes is 45%, so there's room for improvement but some gap is inevitable."

- **Common Exam Traps:**

- **Using °C or °F:** Perhaps the #1 mistake. If T_H and T_L are given in Celsius or Fahrenheit, **convert to Kelvin or Rankine** before plugging in. The exam writers love to see if you know this. For instance, a hot reservoir at 500°C and cold at 20°C gives $\eta_{\text{Carnot}} = 1 - \frac{293}{773} = 0.62$ (62%). If someone incorrectly used 500 and 20 without converting, they'd get $1 - 20/500 = 0.96$ (96%), which is wildly incorrect and unphysical. Always double-check units on temperatures.

- **Identifying T_H and T_L correctly:** T_H is the temperature of the heat source (where heat enters the engine). T_L is the sink (where heat is dumped). In a problem, if they mention a boiler at 550 K and a cooling water at 300 K, use 550 K as T_H and 300 K as T_L. If reversed by accident, you'd get a negative efficiency (!), which should immediately signal an error.

- **Expressing answer as percentage vs fraction:** As with any efficiency, Carnot efficiency might be expected as a percentage. If the formula gives 0.4, that's 40%. Keep an eye on wording like "percentage efficiency."

- **Thinking Carnot is attainable:** Carnot efficiency is a limit, not something you actually achieve in practice. A subtle exam question might ask: "Engine X has an efficiency of 70% while operating between 800 K and 300 K. Is this possible?" First, compute Carnot: $1 - 300/800 = 62.5\%$. A 70% efficient engine between those temps **exceeds Carnot**, so it's impossible. The correct reasoning is that the claim violates the second law. Don't be tricked into thinking some clever design can beat Carnot; on the exam, the answer will be "No, it can't exceed ~62.5% which is the Carnot limit."

Exam Handbook Search Cues (Not affiliated with or endorsed by NCEES): *Carnot*, *maximum efficiency*, $1 - T_L/T_H$, *reversible cycle* (Searching these terms will get you to the Carnot efficiency formula and related second-law statements in the reference.)

Footnotes:

- *Carnot's theoretical nature:* Real engines **never** truly operate on a Carnot cycle. Carnot requires infinitely slow, reversible processes (which would produce zero power output in the limit, because taking infinite time yields zero power even if efficiency is high). So practical engines always involve some compromise between efficiency and power. The FE Exam expects you to know Carnot as an upper bound, not as a realizable cycle for actual machinery.

- *Carnot cycle stages:* For completeness, the Carnot cycle consists of: 1→2: isothermal expansion at T_H (heat in), 2→3: adiabatic

expansion (no heat exchange, temperature falls from T_H to T_L), 3→4: isothermal compression at T_L (heat out), 4→1: adiabatic compression (temperature rises back to T_H). The net effect: work output = $Q_{\text{in}} - Q_{\text{out}}$, and efficiency = $1 - T_L/T_H$. You usually won't need to recount these steps on the exam unless it's a conceptual question asking which processes are isothermal, etc.

- *Reversed Carnot:* If dealing with refrigeration cycles (not exactly this topic, but related), the maximum Coefficient of Performance for a fridge or heat pump is based on the reversed Carnot cycle: $COP_{\text{HP,max}} = \frac{T_H}{T_H - T_L}$ for a heat pump, and $COP_{\text{ref,max}} = \frac{T_L}{T_H - T_L}$ for a refrigerator. These come from algebraic manipulation of the Carnot efficiency formula and the definitions of COP. Just know they exist; use them if a refrigeration question explicitly invokes an ideal (Carnot) fridge.

Explanation & Analysis: The Carnot efficiency formula $\eta_{\text{Carnot}} = 1 - \frac{T_L}{T_H}$ is elegant and powerful. It distills the second law limits into one simple expression. Let's interpret it: it says that the efficiency is 100% *only* if the cold temperature T_L is 0 (absolute zero), which is unattainable. For any real, positive T_L, some fraction T_L/T_H of the heat is inherently lost. This fraction is essentially the unavoidable entropy cost of dumping heat to the environment. Another view: $\frac{T_L}{T_H}$ is how much *of the input heat* must be rejected, in theory, even if everything is ideal. So Carnot tells us **the minimum** Q_{out} **possible** for a given Q_{in}, namely $Q_{\text{out,min}} = \frac{T_L}{T_H} Q_{\text{in}}$. If your engine dumps more heat than that, it's less efficient than Carnot (which is expected for real engines).

When using the Carnot formula in exam problems, the procedure is usually straightforward: identify the hot and cold reservoir temperatures, convert to absolute units, plug in and compute the efficiency. For example, suppose a question states: "A power plant operates between a boiler temperature of 500°C and a cooling water temperature of 20°C. What is the maximum possible thermal efficiency?" You'd do $T_H = 500 + 273 = 773$ K, $T_L = 20 + 273 = 293$ K, then $\eta_{\text{max}} = 1 - 293/773 \approx 0.62$ or 62%. This would be the answer (and you might note that actual plants will be lower).

It's worth noting how **Carnot efficiency shapes engineering decisions**: If raising T_H by 10 K yields a bigger efficiency gain than lowering T_L by 10 K, you might choose the former if feasible. In many applications, T_L is basically the ambient temperature (hard to go lower), so improving efficiency comes down to raising T_H (up to material limits) or using multiple stage cycles (like reheat or combined cycles) to effectively get closer to an ideal multiple-temperature heat addition. The simple Carnot formula thus underlies why we pursue technologies like **supercritical boilers** (to elevate T_H) and **better cooling** (to reduce T_L slightly, e.g. via cooling towers).

From an exam perspective, also remember Carnot's corollary: **No engine can be more efficient than a Carnot engine operating between the same two temperatures.** If they give you an outrageous claim about some engine's efficiency, comparing it to Carnot settles viability. For instance, an engine between 300 K and 600 K cannot be more than 50% efficient Carnot-wise. If someone says theirs is 60%, you know it's impossible on principle. This is a qualitative use of Carnot that might appear in conceptual questions.

In summary, the Carnot cycle isn't something you "calculate through" step by step in detail on the FE (since no one will ask you the intermediate states or work of each process in Carnot), but its efficiency formula is a must-know. It sets the aspirational ceiling for all the real cycles—Otto, Diesel, Brayton, Rankine—that we'll discuss next. Keep it in mind as we examine how those common cycles compare to the Carnot ideal and what trade-offs they make.

K11.T06.S03 – Common Thermodynamic Power Cycles (Rankine, Brayton, Otto, Diesel)

Principle Introduction:

- Real engines and power plants operate on cycles that approximate certain idealized **thermodynamic cycles**. Four of the most important ones for the FE exam are:

1. **Rankine Cycle** – models steam turbine power plants (external combustion, vapor power cycle).

2. **Brayton Cycle** – models gas turbine engines (internal combustion or external heat, but continuous flow gas cycle).

3. **Otto Cycle** – models spark-ignition internal combustion engines (like gasoline/petrol car engines, with pistons).

4. **Diesel Cycle** – models compression-ignition engines (diesel engines, also piston engines but with a different combustion process). - Each cycle has a distinct sequence of processes (e.g. constant-pressure vs constant-volume heat addition) which leads to different efficiency formulas and performance characteristics.

Understanding the key process steps and knowing which cycle corresponds to which set of processes is a classic FE exam task. For example, you might be given a P–V diagram and asked, "Is this an Otto or Diesel cycle?" or asked to recall the efficiency formula for an Otto cycle in terms of compression ratio.

- In ideal form, these cycles assume internally reversible processes (aside from the intended heat addition/rejection paths) and often use simplifying assumptions like air-standard (treating the working fluid as air with constant specific heats, especially for Otto and Diesel). While not as efficient as the Carnot cycle (since heat addition and rejection happen over a range of temperatures, not isothermally), they are more realistic models of actual machines.

- We will outline the basic process diagram for each cycle and provide their ideal efficiency expressions. Memorize which process is isochoric (constant volume), isobaric (constant pressure), or isentropic in each cycle – exam questions often hinge on identifying these.

Diagram/Definition Passport – Ideal Heat Engine Cycles
(Below we summarize each of the four cycles with their characteristic processes and formulas. Imagine the P–V diagram for Otto and Diesel as the classic rectangles/curves in a piston cylinder, and T–s or P–h diagrams for Brayton and Rankine as described.)

Otto Cycle (Ideal Gasoline Engine):

- **Process sequence:** 1–2: Isentropic compression (piston compresses air-fuel mix, no heat exchange). 2–3: **Constant-volume heat addition** (fuel combusts rapidly at essentially constant volume – this is the ignition/burning phase in an ideal model).
  3–4: Isentropic expansion (power stroke, piston pushed by expanding hot gases, no heat lost during expansion). 4–1: **Constant-volume heat rejection** (exhaust

blowdown in ideal model, volume at bottom dead center, releasing heat to exhaust to close the cycle).

- **Key traits:** Both heat addition and rejection occur at constant volume in the Otto cycle. This is a distinctive feature – if you see constant-volume processes on a P–V diagram, you're likely dealing with an Otto cycle.
- **Efficiency formula:** $\eta_{\text{Otto}} = 1 - \frac{1}{r^{\gamma-1}}$. Here $r = \frac{V_1}{V_2}$ is the **compression ratio** (ratio of cylinder volume before compression to after compression, i.e. $V_{\max}/V_{\min}$ in the piston), and $\gamma = c_p/c_v$ is the specific heat ratio of the working gas (for air, $\gamma \approx 1.4$). This formula tells us Otto efficiency depends only on compression ratio (higher r gives higher efficiency) for a given γ. **Example:** If $r = 8$ and $\gamma = 1.4$, $\eta_{\text{Otto}} \approx 1 - 1/8^{0.4} \approx 56\%$ (ideal). Real engines achieve less due to non-idealities.
- **Typical uses:** Spark-ignition engines (cars, small generators). The Otto cycle assumes the fuel-air mix is introduced then compressed; ignition occurs at top dead center causing a rapid pressure rise at constant volume.

Diesel Cycle (Ideal Diesel Engine):

- **Process sequence:** 1–2: Isentropic compression (piston compresses air *only* in a diesel, no fuel yet, to a high temperature). 2–3: **Constant-pressure heat addition** (fuel is injected at point 2 and burns while the piston is moving, such that pressure stays roughly constant while the volume expands; this is an idealization of the slow combustion in diesel). 3–4: Isentropic expansion (power stroke, similar to Otto's expansion but now starting from a different state since heat was added at constant pressure). 4–1: **Constant-volume heat rejection** (at bottom of expansion, the exhaust valve opens, releasing heat at essentially constant volume as pressure drops).
- **Key traits:** Diesel has heat addition at constant **pressure** (instead of constant volume) and still has heat rejection at constant volume. On a P–V diagram, you'll see the combustion phase as a horizontal line (constant pressure) rather than a vertical rise. If the problem mentions "heat added at constant pressure," think Diesel.
- **Efficiency formula:** $\eta_{\text{Diesel}} = 1 - \frac{1}{r^{\gamma-1}} \cdot \frac{r_c{}^{\gamma} - 1}{\gamma(r_c - 1)}$. This looks more intimidating than Otto's formula. Here r is again the compression ratio V_1/V_2, and $r_c = \frac{V_3}{V_2}$ is the **cutoff ratio** (the ratio of volumes at the end vs. start of the heat addition process, i.e. how much the piston moved during the fuel injection burn). γ is the specific heat ratio as before. If $r_c = 1$, meaning heat addition happened instantaneously with no volume change, the formula simplifies to Otto's formula – which makes sense because Diesel becomes Otto in that limit.
- **Efficiency trends:** For a given compression ratio r, Diesel cycle is *less efficient* than Otto cycle because of that factor $\frac{r_c{}^{\gamma} - 1}{\gamma(r_c - 1)}$, which is >1 for any $r_c > 1$, thus making $1 - \frac{1}{r^{\gamma-1}} \cdot$ (something >1) smaller. However, in practice, diesel engines use much higher compression ratios (typically $14:1$ up to $20:1$ or more, whereas gasoline might be $8:1$ to $10:1$) because diesel fuel auto-ignites rather than knocking. The higher r largely compensates, giving real diesel engines higher efficiency than real gasoline engines. But **exam wise, if asked "for the same compression ratio, which ideal cycle is more efficient?" the answer is Otto > Diesel (Otto's constant-volume combustion is more efficient than Diesel's constant-pressure combustion at the same r).**
- **Typical uses:** Compression-ignition engines (diesel trucks, some generators). The Diesel cycle model captures the fact that fuel is injected as the air is already compressed and burning happens more gradually than in Otto.

Brayton Cycle (Ideal Gas Turbine):

- **Process sequence:** 1–2: Isentropic compression of an ideal gas (in a compressor – this is a steady-flow compression, not piston, but the thermodynamics is similar: pressure rises, volume shrinks, entropy constant ideally). 2–3: **Constant-pressure heat addition** (in a combustor or heat exchanger, the gas is heated from state 2 to 3 at roughly constant pressure – in a jet engine combustor, the flow moves through and heat is added without much pressure change, ideally). 3–4: Isentropic expansion (through a turbine, the gas expands and does work, ideally reversible adiabatic). 4–1: **Constant-pressure heat rejection** (the gas returns to the intake state by releasing heat at constant pressure, for an open-cycle gas turbine this happens as exhaust expels to atmosphere at essentially ambient pressure).
- **Key traits:** Both heat addition and rejection are at constant **pressure** in Brayton. This distinguishes it from Rankine (phase change) and the Otto/Diesel (which have constant volume steps). Also, Brayton is typically an **open cycle** in reality (intake air, exhaust gases), but we model it as a closed cycle with the same fluid for simplicity (air-standard assumption). If you see a cycle with two isobaric processes and two isentropic processes on a T–s diagram (with the isentropes nearly vertical and isobars horizontal), that's Brayton.
- **Efficiency formula:** For an ideal Brayton (air-standard), $\eta_{\text{Brayton}} = 1 - \frac{T_1}{T_2} = 1 - \frac{1}{r_p{}^{(\gamma-1)/\gamma}}$. Here $r_p = \frac{P_2}{P_1}$ is the **pressure ratio** of the compressor (also equal to P_3/P_4 for the turbine in an ideal cycle). T_1 is the compressor inlet temperature and T_2 is the compressor outlet temperature. The relation $T_2/T_1 = r_p{}^{(\gamma-1)/\gamma}$ (for isentropic compression of ideal gas) gives the alternative form. This formula implies that increasing the pressure ratio r_p raises efficiency (similar to how raising compression ratio raises Otto efficiency). However, there are diminishing returns and practical limits (material and compressor design constraints).
- **Notes:** Brayton efficiency formula looks a lot like Carnot's form, but note that T_1 and T_2 are not the extreme reservoir temperatures – T_1 is ambient intake, T_3 (peak temperature after combustion) might be much higher. The $\eta = 1 - T_1/T_2$ result assumes a certain symmetry in the cycle (same γ, ideal processes). In practice, modern gas turbines reach high pressure ratios (10:1 up to 30:1 or more) and also use techniques like intercooling, reheat, and regeneration to boost efficiency (though those stray from the simple Brayton cycle). On the FE exam, you should primarily know the basic Brayton cycle and its efficiency trend: higher pressure ratio → higher ideal efficiency.
- **Typical uses:** Aircraft jet engines, industrial gas turbines for power generation. The Brayton cycle is a steady-flow cycle; in diagrams, it's often shown on a T–s plot as two adiabatic vertical lines and two horizontal constant-

pressure lines, or on a P–v plot as two isentropic curves and two horizontal lines (since isobaric process in P–v looks horizontal).

Rankine Cycle (Ideal Steam Power Plant):

- **Process sequence:** 1–2: **Isentropic pumping** (water at liquid state is pumped from low pressure to high pressure – ideally no entropy change, just a pressure rise, with a small work input). 2–3: **Constant-pressure heat addition** in the boiler (liquid water is heated to saturation and vaporized into steam, and possibly superheated, all at essentially boiler pressure which is constant; heat is added here from a furnace or other external source). 3–4: Isentropic expansion in a turbine (high-pressure steam expands through the turbine producing work, ideally reversible adiabatic, dropping to condenser pressure). 4–1: **Constant-pressure heat rejection** in the condenser (the spent steam condenses back to liquid water at low pressure, releasing latent heat to cooling water, at a constant condenser pressure and temperature).
- **Key traits:** Rankine is a **vapor cycle** (phase change involved). Heat addition occurs mostly at constant pressure *but not at constant temperature* (except during the phase-change part: boiling at constant temperature if saturated). Heat rejection is at constant pressure (condensing at a fixed saturation temperature). Unlike the previous cycles, Rankine deals with liquid and vapor – you can spot it by mention of a **boiler, condenser, pump, and turbine**. P–v and T–s diagrams for Rankine have distinct shapes (e.g. on a T–s diagram, 2–3 follows the saturated liquid line then the saturated vapor line if no superheat).
- **Efficiency consideration:** There isn't a single simple formula like the others because the working fluid doesn't follow PV^{γ} or such simple relations due to phase change. Instead, **thermal efficiency** of Rankine is $\eta = \frac{W_{\text{turbine}} - W_{\text{pump}}}{Q_{\text{boiler}}}$. In terms of enthalpies (from steam tables): $W_{\text{turbine}} = h_3 - h_4$, $W_{\text{pump}} = h_2 - h_1$ (which is usually small), and $Q_{\text{boiler}} = h_3 - h_2$. So, $\eta_{\text{Rankine}} = \frac{(h_3-h_4)-(h_2-h_1)}{h_3-h_2} = 1 - \frac{h_4-h_1}{h_3-h_2}$. Essentially $1 - \frac{\text{heat out}}{\text{heat in}}$ again, where $h_4 - h_1$ is the enthalpy drop in the condenser (heat rejected). You aren't expected to memorize this form, but you should know how to apply energy balances to get efficiency if given enthalpies.
- **Typical efficiency:** Due to the large latent heat in boiling (a lot of heat added at relatively low temperature in the boiler), a simple Rankine cycle's efficiency is much lower than the Carnot efficiency between boiler and condenser temperature. For example, if the boiler is at 450°C (723 K) and condenser at 40°C (313 K), Carnot gives ~56%, but an actual Rankine might be 35%. This gap is because not all heat is added at the maximum temperature (some is added while water is just warming up or evaporating at a lower temp). Engineers use **superheating, reheat, and regeneration** (topic 11.6.4) to mitigate this.
- **Typical uses:** Coal, nuclear, biomass, and solar-thermal power plants – basically any power plant where water is boiled to drive a steam turbine. Also, old steam locomotives (Rankine cycle on wheels).

Exam Handbook Search Cues (Not affiliated with or endorsed by NCEES): *Otto cycle*, *Diesel cycle*, *Brayton cycle*, *Rankine cycle*, *compression ratio*, *pressure ratio*, *isentropic*, *constant volume*, *constant pressure* (These keywords will point you to diagrams or formulas for these cycles in the reference handbook.)

Footnotes & Insights:

- *Air-standard assumption:* For Otto, Diesel, and Brayton, we often assume an ideal gas (air) with constant γ as the working fluid throughout, ignoring the chemistry of fuel combustion and treating heat addition as just that – heat from an external source. This simplifies analysis and yields the neat efficiency formulas above. It also explains why γ (specific heat ratio) appears in the formulas. If γ changes (e.g., high temperature might reduce it slightly), the formula would adjust. For the FE exam, treat γ as constant for these ideal cycle formulas (use 1.4 for diatomic air unless told otherwise).

- *Typical γ values:* Dry air is about 1.4 at room temp. If a problem needed it, they'd likely supply γ or say "treat as ideal air $\gamma = 1.4$". Just know γ is dimensionless (ratio of heat capacities) and is >1. For monatomic gases like ideal helium, $\gamma = 1.67$, which would give a higher ideal efficiency for the same compression ratio – interesting theoretical note but most engines use diatomic gases.

- *Otto vs Diesel efficiency:* A classic theoretical question: Given the same compression ratio, which cycle is more efficient, Otto or Diesel? **Answer: Otto.** This sometimes surprises people since diesels are known to be efficient. The catch is "same compression ratio" – diesels usually operate at higher r than gasoline engines. But if you forced a diesel to run at the same r as an Otto, the fact that it adds heat at constant pressure (lower average temperature of heat input) makes it have lower efficiency. For exam purposes, remember: **Otto > Diesel for same** r. However, **real-world diesels have higher** r which usually gives them actual efficiency higher than gasoline engines. It's a fine point that the exam may test conceptually.

- *Mean effective pressure (MEP):* You might bump into this term in the context of Otto/Diesel (especially in the handbook's mechanical section). MEP is a fictitious constant pressure that, if it acted on the piston throughout the power stroke, would generate the same net work as the real cycle. It's a way to compare engines. While not explicitly in our outline, if seen, just recall: a higher efficiency or work output for given displacement implies higher MEP. But detailed calc is probably not needed unless a problem gives formula.

- *Brayton vs Rankine:* Both are **external heat** cycles (meaning the heat source is external for Rankine, and for Brayton it can be internal via fuel burning but steady flow). But Brayton is gas throughout, Rankine is phase-change. Brayton typically achieves higher temperatures (since it's limited by materials in the turbine, maybe 1500 K inlet in modern units) whereas Rankine max temperature is often limited by metallurgical constraints in boilers (~873 K or so for subcritical, ~1073 K for supercritical steam). Brayton's efficiency can rival or exceed Rankine's in simple form at high pressure ratios, but combined cycles (using Brayton's exhaust to drive a Rankine bottoming cycle) are common to harness the best of both. For FE exam, you usually won't need to compare these two directly, but it's good context.

- *Cycle diagrams:* Be familiar with the qualitative shape of P–V and T–s diagrams for each cycle: - Otto: P–V diagram looks like two adiabats connecting two isochoric steps (a sort of rounded rectangle shape). T–s diagram would show two vertical lines for isentropics and two horizontal-ish lines (not exactly horizontal because of varying specific heats) for constant volume (since volume constant in a closed system means an entropy change at varying T). - Diesel: P–V diagram has one constant-pressure

segment (an almost flat line) and one constant-volume segment, with adiabats connecting them. - Brayton: T–s diagram is easiest – looks like a rectangle: two vertical isentropic lines and two horizontal isobars. P–v for Brayton is harder to visualize due to continuous flow, but one can draw something qualitatively similar to Otto's shape but stretched. - Rankine: T–s diagram has the famous shape following liquid water heating, boiling (horizontal line at constant T), then superheating (rising temp at constant pressure), then expansion (dropping T and increasing entropy), then condensation (horizontal line at low T), closing with pumping (vertical up line very near the left edge since liquid water entropy change is tiny). Understanding these can help answer qualitative questions like "what happens to moisture content if we add reheat?" or "what process increases entropy the most?" etc.

Variations & Related Forms:

- **Dual Cycle:** (FYI) There is an ideal cycle that combines features of Otto and Diesel, called the Dual cycle (heat added partly at constant volume, partly at constant pressure) – used to model some modern high-pressure engines. It's not commonly tested, but just in case: its efficiency falls between Otto and Diesel for the same compression ratio and cutoff parameters. Not a focus for FE unless specifically mentioned.

- **Brayton with regeneration/intercooling/reheat:** A modified Brayton can have a **regenerator** (to use exhaust heat to preheat air entering combustor), **intercooling** (cool the air between multi-stage compression to reduce compressor work), and **reheat** (add fuel and heat in two stages between multi-stage expansion to increase work output). These improve efficiency or output. While detailed analysis is beyond FE scope, you should recognize the terms: regeneration in Brayton improves efficiency by raising average heat-add temperature (just like feedwater heating in Rankine), intercooling reduces work input (but could lower efficiency if not recovered), reheat raises output and can improve efficiency if exhaust heat is recovered.

- **Combined Cycles:** Gas-steam combined cycles use a Brayton (gas turbine) topping cycle and a Rankine bottoming cycle, reaching overall efficiencies of 50–60%. The FE might not ask for details, but you should know why they exist: to utilize the high-quality waste heat from Brayton's exhaust to produce more work in a Rankine cycle. This ties into the idea of pushing closer to Carnot by effectively having multiple heat addition temperatures.

- **Organic Rankine Cycle (ORC):** Again not likely on FE, but just to avoid confusion: ORC is like Rankine but with organic fluids for low-temperature heat sources (geothermal, waste heat). It's essentially the same principles, just a different working fluid.

Explanation & Analysis: Let's tie this together with a comparative perspective, as that's often how exam questions approach it. Suppose you're asked: *"In which ideal cycle is heat added at constant volume?"* You should instantly recall: that's Otto (constant volume heat addition). If asked *"Which cycle has two constant-pressure processes?"* – that's Brayton (and also Diesel has one constant-pressure process, Rankine has constant-pressure heat addition too but accompanied by phase change). The key is to have a mental chart of each cycle's distinguishing features.

Otto and Diesel (Reciprocating engines): Both are **piston-cylinder intermittent cycles**. The main difference is how the combustion (heat addition) occurs: Otto bangs it all at once (volume constant, pressure spikes), Diesel feeds it gradually (pressure constant, volume expands during burn). This leads to different efficiency formulas. On the FE, if given numeric values, you might be asked to compute η_{Otto} given r and γ – a plug-and-chug into $1 - r^{-(\gamma-1)}$. Or for Diesel, given r and r_c, plug into the Diesel formula. Ensure you're comfortable manipulating those exponents on your calculator (e.g. $r^{\gamma-1}$ or $r_p{}^{(\gamma-1)/\gamma}$ for Brayton). A good practice is to use the y^x or ^ operator and grouping the exponent correctly. For instance, $r^{\gamma-1}$: if $r = 8$ and $\gamma = 1.4$, compute $8^{(1.4-1)} = 8^{0.4}$.

Brayton (Gas turbine): Think of this as a **continuous flow counterpart** to Otto/Diesel. Instead of discrete strokes, air is compressed continuously, fuel is burned at (ideally constant pressure), and expansion is through a turbine. The math uses pressure ratio instead of volume ratio because in open flow, pressure jumps are what we can easily control. The efficiency formula $1 - 1/r_p{}^{(\gamma-1)/\gamma}$ essentially comes from combining the isentropic relation $T_2/T_1 = (P_2/P_1)^{(\gamma-1)/\gamma}$ with $\eta = 1 - T_1/T_2$ (which itself comes from the fact that for an ideal Brayton, $T_4/T_3 = T_2/T_1$ due to symmetric isentropic processes). If you blank on that formula, you could derive it with a couple of steps if you remember $T_2 = T_1 \cdot r_p{}^{(\gamma-1)/\gamma}$ and that in an ideal Brayton $T_4 = T_1$ (if the cycle comes back to same state 1) and $T_3 = T_2 \cdot (T_4/T_1)$ actually scratch that, easier: memorize it! It's a safe bet to just memorize $\eta_{\text{Brayton}} = 1 - 1/r_p{}^{(\gamma-1)/\gamma}$. It looks like Carnot $(1 - T_{\text{low}}/T_{\text{high}})$ but not exactly: T_1 and T_2 are not the extreme reservoir temps, they are just the compressor inlet and outlet. But T_1 is usually ambient, which in an open cycle is the low reservoir effectively, and T_2 is the after-compression temp (lower than the peak turbine inlet temp T_3, but it plays the analogous role in the formula).

One **common analysis point**: Brayton vs Otto efficiency for same compression ratio (if you were to make an analogy, say r_p corresponds to some effective compression). It turns out for the same peak temperature and compression, the cycles differ – but such cross comparisons are beyond FE scope typically. However, do know that **Otto and Diesel are closed volume cycles, Brayton is open steady flow – their efficiency formulas look different because of that**.

Rankine (Steam cycle): This one requires familiarity with steam tables if you had to calculate something, but often FE problems keep it conceptual or give you needed enthalpies. A typical problem might give you turbine inlet and outlet conditions and ask for efficiency. You'd compute the work and heat as enthalpy differences and do the ratio. For example: "Steam enters a turbine at 4 MPa, 400°C (h = X kJ/kg) and exits at 50 kPa, x = 0.9 (h = Y kJ/kg). Water leaves the condenser as saturated liquid at 50 kPa (h = Z kJ/kg). Pump elevates it back to 4 MPa (h ≈ Z kJ/kg + small). Find efficiency." You'd do: $W_{\text{turbine}} = X - Y$, $W_{\text{pump}} \approx Z_{\text{pump exit}} - Z_{\text{pump inlet}}$ (which is small, often you might even approximate pump work if not given by $v\,\Delta P$), $Q_{\text{in}} = X - (Z_{\text{pump exit}})$. Then $\eta = \frac{(X-Y)-(Z_{\text{pump exit}}-Z)}{X-(Z_{\text{pump exit}})}$. That arithmetic can be tedious, but they might simplify by neglecting pump work or providing numbers. The key concept: Rankine's inefficiencies largely stem from the fact that a large amount of energy is required to boil water (going from liquid to vapor) at a relatively moderate temperature. A lot of heat in at lower temperature = lower efficiency (Carnot reasoning).

Thus, improvements: **superheat the steam** (so more heat is added at higher temps, raising average T_{add}), **reheat** the steam (split expansion into two stages so you can add heat again at a high temp halfway through), and **regenerate** (use bled steam to preheat feedwater so you don't waste high temp heat in raising water from,

say, 30°C to 150°C, instead use some medium temp steam to do that). These tricks effectively make the Rankine cycle's heat-add process more like a high-temperature process and less like a mixture of high and low temperature additions.

One last thought for exam readiness: you should be comfortable identifying what cycle an engine or plant is using from a brief description. If the question mentions a **turbine, compressor, combustor**, it's Brayton (gas turbine). If it mentions **boiler, condenser, steam**, it's Rankine. If it's a **piston engine with spark plug**, it's Otto. If it's a piston engine that compresses air then injects fuel (glow plug or fuel injector, no spark), it's Diesel. Sometimes questions use those contextual cues instead of explicitly naming the cycle.

To conclude, these common cycles are about recognizing patterns. Each ideal cycle provides a simple model that captures the essence of real machines. The FE exam expects you to know the **identity** (which processes define which cycle), the **efficiency formulas** for Otto, Diesel, Brayton (memorize them), and the general strategy for Rankine efficiency calculation (use enthalpies and first law). If you know those, you can confidently tackle questions like "An ideal Diesel engine has a compression ratio of X and cutoff ratio of Y, find its efficiency," or "What modification in a Rankine cycle can improve efficiency?" (you'd answer reheat or regeneration), or "Compare an ideal Otto and Diesel engine for the same compression ratio." Being fluent in these cycles turns what could be a convoluted problem into a straightforward application of principles you've mastered.

K11.T06.S04 – Regenerative & Reheat Cycles (Improving Rankine Efficiency)

Principle Introduction:

- The basic Rankine cycle, while effective, leaves some efficiency on the table because not all heat is added at the highest possible temperature. To improve a steam cycle's performance, engineers implement **regeneration** and **reheat**. These are two common modifications to the Rankine cycle that **increase thermal efficiency** by raising the average temperature at which heat is added or by reducing losses.

- **Regenerative feedwater heating (Regeneration):** This involves bleeding off some steam from the turbine partway through its expansion and using it to preheat the feedwater (the liquid water on its way to the boiler). By doing so, the feedwater enters the boiler at a higher temperature, meaning the boiler doesn't have to supply as much heat at lower temperatures – effectively, more of the heat addition occurs at higher temps. This pushes the cycle's efficiency closer to the Carnot ideal.

- **Reheat cycle:** This technique splits the turbine expansion into two (or more) stages. Steam expands partially in a high-pressure turbine, then is sent **back to the boiler** (or a reheater section) to be heated again (reaching near the original high temperature), and then continues expanding in a low-pressure turbine. Reheat raises the minimum temperature during the expansion and increases the work output. It also significantly **reduces moisture** at the final stages of expansion (wet steam in turbines can damage blades, so keeping steam drier by reheat is a practical benefit).

- On the FE exam, you should grasp **what regeneration and reheat accomplish**: higher efficiency and why. You may be asked conceptually, "What is the effect of using a feedwater heater on a Rankine cycle?" or "Why is steam reheated in a power plant cycle?" The answers revolve around efficiency gains and moisture reduction. Calculations might be as simple as a qualitative change in efficiency or, at most, computing an efficiency with given enthalpies including extraction. But typically, it's the concept that's tested.

Definition/Note Passport – Regeneration & Reheat in Rankine Cycles

- **Regenerative Feedwater Heating (Open or Closed Feedwater Heaters):** In regeneration, a portion of steam is bled from the turbine at an intermediate pressure. In an **open (direct-contact) feedwater heater**, this steam **mixes with the feedwater**, warming it while the steam **condenses into liquid water**. In a **closed feedwater heater** (heat exchanger), the bleed steam flows in coils and transfers heat to the feedwater without mixing. Either way, the feedwater leaving the heater is warmer than it would be coming straight from the pump. This means the boiler will heat water that's already partway hot, so it spends more of its energy on the high-temperature part of heating.

Effect on efficiency: The cycle efficiency increases because the area on the T–s diagram for heat addition at low temperature is reduced (replaced by using internal heat from bleed steam). Essentially, we're recovering some energy that would otherwise be wasted in the condenser and using it to preheat the water. The trade-off is a bit less mass flow through the last stages of the turbine (since some steam was extracted earlier), which can reduce total power output for a given boiler flow – but the efficiency (work per unit heat input) improves.

- *Exam tip:* An open feedwater heater brings the feedwater to the saturation temperature corresponding to the extraction pressure (since mixing causes equilibrium). A closed feedwater heater can heat feedwater to a temperature below the saturation temp of the extracted steam (since no mixing). Multiple feedwater heaters can be used in large plants. The FE exam might simply ask "why use feedwater heaters?" and you'd answer: to increase efficiency by raising feedwater temperature using extracted steam (regeneration).

- **Reheat Cycle:** In a reheat-equipped Rankine cycle, steam after partial expansion (say from high pressure down to an intermediate pressure) is diverted back to the boiler and heated again to a high temperature (often the same or slightly lower than the original turbine inlet temperature). Then this reheated steam goes into the next turbine stage for further expansion to condenser pressure. **Effect on efficiency:** Reheat increases the average temperature of heat addition – you are adding heat twice, and the second time is at a pretty high temperature rather than letting the steam cool all the way down in one go. That improves efficiency somewhat (though not as dramatically as regeneration typically; reheat's primary benefit is often more on the output and moisture side). **Effect on output and moisture:** Reheat allows a larger total expansion ratio without making the steam overly wet at the final stage. Without reheat, expanding from, say, 16 MPa/600°C all the way to 10 kPa in one turbine would leave the steam maybe ~85% quality (15% liquid) at exit. With reheat, you cut the expansion, reheat, and then the final exit quality might be 90%+ which is much safer for the turbine blades. Plus, reheat adds extra area on the T–s diagram (more work output area) because the steam goes back to a higher enthalpy and expands again – so you get more work for relatively modest extra heat input. Net effect: higher efficiency and significantly more work output.

- Most power plants use **single reheat** (steam goes through two turbines: HP and LP). Some supercritical plants use **double reheat** (three turbine stages). Each reheat increases complexity but ekes out a bit more efficiency. For FE exam purposes, know single reheat conceptually. If given a problem with reheat, you might have enthalpies for each stage and you'd compute total work = $h_{\text{in,HP}} - h_{\text{out,HP}} + h_{\text{in,LP}} - h_{\text{out,LP}}$ and total heat in = $h_{\text{in,HP}} - h_{\text{feedwater}} + h_{\text{in,LP}} - h_{\text{out,HP}}$ etc., but that's a lot. More likely they'll ask, "What is the primary reason to reheat steam in a Rankine cycle?" (Answer: to improve efficiency and avoid excessive moisture in the turbine).

- **Overall Impact:** Both regeneration and reheat bring the Rankine cycle's performance closer to what you'd get if you could add all heat at the top temperature and reject at the lowest temperature – i.e. closer to Carnot. They are complementary: **Regeneration** increases efficiency by reducing low-temp heat addition; **Reheat** increases efficiency by raising the temp of later heat addition and allows deeper expansion (more work) without moisture issues. A regenerative Rankine with reheat and multiple feedwater heaters can achieve much higher efficiency than a simple Rankine. Real power plants reach on the order of 40%+ efficiency with these modifications, versus maybe 30-35% without.

- **Pitfalls/Considerations:** There's diminishing returns and practical limits. Too many feedwater heaters or too aggressive steam extraction could mean not enough flow in the turbine final stages (reducing power too much), and each heater/turbine stage adds cost and complexity. Reheat adds another pass through boiler tubes which increases boiler size and cost. So in design, a balance is struck. None of that is tested on FE, but be aware that "more reheat/regeneration" isn't always better beyond a point.

- **Micro-check:** *True/False:* In a reheat Rankine cycle, the steam quality at the turbine exhaust is higher (drier steam) than it would be in a single-expansion cycle without reheat. *(Think about it: Reheat should increase exit quality – so this statement is True.)*

Exam Handbook Search Cues (Not affiliated with or endorsed by NCEES): *reheat*, *feedwater heater*, *regeneration*, *Rankine improvement*, *open feedwater heater equation*, *bleed steam* (Searching terms like these in the handbook might show references to feedwater heater equations or the description of reheat.)

Footnotes:

- *Open vs Closed Feedwater Heaters:* The exam won't likely dive into the equations we saw (the handbook has formulas like $m_1 h_1 + m_2 h_2 = m_3 h_3$ for an open heater mixing, which basically is energy balance). Just know open heaters mix streams (so feedwater leaves at the extraction steam's saturation temp) while closed heaters keep streams separate (feedwater can exit at below extraction steam saturation temp, and the extracted steam is often throttled to condenser after giving up heat). The distinction is more design-level; conceptually both do the same duty: raise feedwater enthalpy.

- *Effect on T–s diagram:* Regeneration in an ideal T–s diagram for Rankine is shown by a vertical line segment for the feedwater heating that uses extracted steam – effectively the pump line (1–2) followed by feedwater heating steps raises the water entropy a bit before the main boiler heating. Reheat is shown by an extra loop: after the first expansion, you draw a line going back up at roughly constant pressure (the reheat process, which on T–s looks like moving right and up, because entropy increases a bit with the addition of heat at high pressure) then the second expansion. In sum, these modifications reshape the area of the cycle on T–s to be more efficient (more area under high-temperature process, less under low-temp).

- *Other enhancements:* Superheating (which is basically part of a standard Rankine: heat beyond saturation in the boiler) is another efficiency booster – ensures that the average temperature of heat input is higher. It also improves turbine exit quality. Think of superheat as reheat done at the start (before expansion) rather than mid-way. All modern Rankine cycles have some degree of superheat.

- *Economizer:* Not to confuse, but in boilers, an economizer uses outgoing flue gas to preheat feedwater too (that's outside the Rankine cycle per se, more of a boiler internal thing). It's a similar idea to regeneration but on the gas side. FE exam won't require detail on that, but just showing that many layers of heat recovery exist to inch closer to ideal.

Special Notes – Calculator: If you ever need to calculate efficiency with regeneration or reheat and you're given flows or enthalpies, just be systematic. For regeneration with an open feedwater heater, usually you solve for the extracted fraction by mass balance and energy balance. It could be a bit too involved for FE, but an easier scenario: they might give you the fraction extracted and ask for efficiency. You'd then compute heat input as main boiler heat plus reheat heat, and work as sum of turbine works minus pump works. This is heavy for a timed exam unless it's multiple choice and the numbers simplify. So likely, **qualitative understanding is key**, not heavy number crunching. So focus on the "why" and "what happens if" type implications.

Explanation & Analysis: *Why does regeneration improve efficiency?* Because it takes advantage of internal heat that would otherwise be wasted. A Carnot perspective: if you can avoid adding heat at a low temperature, you avoid paying the penalty of low efficiency for that portion. In a simple Rankine, the water entering the boiler might be, say, feedwater at 50°C. The boiler then has to heat it from 50°C to boiling point (maybe hundreds of degrees) – during that initial heating, the temperature is low, so those portions of heat are adding very little to output (they're almost like a low-temperature cycle, which is inefficient). If instead you use some steam from the turbine to heat that feedwater from 50°C to, say, 150°C, then the boiler starts its job from 150°C upward. The heat used to get from 50° to 150° came from steam that was at, say, 200°C condensing – which is a higher efficiency use of that energy than just throwing it to the condenser. So overall, more of the boiler's heat input is at higher temp, making the cycle more efficient. The cost is that the steam you bled off doesn't go through the rest of expansion, so you lose some work from that steam. But often the loss in work is smaller percentage-wise than the savings in boiler heat, thus net efficiency rises.

Why does reheat improve efficiency and output? Think of the expansion in two steps. Without reheat, once steam starts expanding from the boiler condition, it cools down continuously. The tail end of expansion is at a much lower temperature, meaning the last bits of heat being converted to work are not very effective (low temperature difference, thus low Carnot efficiency locally). If you instead stop expansion halfway, reheat the steam (giving it more energy at a high temperature again), and then expand, you've

effectively increased the portion of work that is done at higher temperature levels. Also, reheat increases the total work output because you've added more heat and extracted more work from that heat, typically at a fairly efficient temperature range. Efficiency can improve because the average temperature of heat input goes up a bit (that reheat happens at a high temp, though not as high as initial because pressure is lower). It's possible in some cases reheat could slightly lower the fraction of heat converted to work if done improperly, but generally one reheat improves efficiency. At minimum, it greatly benefits the turbine by preventing excessive moisture. So from a **pragmatic view**, reheat is often justified just by the fact you can expand deeper (to lower condenser pressure) without water droplets forming as much. That lets you extract more energy (work) out of the steam (so effectively raising efficiency too).

In exam terms, if a question asks "What is the primary benefit of reheating steam in a Rankine cycle?" a safe answer: **"It increases the cycle efficiency and increases the quality of steam at turbine exhaust by raising the average temperature of heat addition."** For regeneration: **"It increases efficiency by using extracted steam to preheat feedwater, thus reducing the amount of low-temperature heat addition required."**

A numerical example to cement it: Suppose a simple Rankine cycle had an efficiency of 35%. Now you add one feedwater heater, maybe efficiency jumps to 38%. You add reheat, maybe it jumps to 40% and your turbine last-stage dryness goes from 85% to 95%. These numbers are illustrative. The point is each method inches closer to the theoretical limit (Carnot between max steam temp and condensing temp, which might be, say, 45% in this hypothetical). You'll never get all the way to Carnot, but regeneration and reheat help close the gap.

Another interesting thing: The **exam might present a T–s diagram with reheat or regeneration and ask you to identify what's going on.** For example, they might show a Rankine T–s with two expansion lines (that indicates reheat) or with a feedwater heating segment (a kink in the pump line where entropy increases at almost constant enthalpy, indicating mixing of extracted steam). If you understand the conceptual shape, you can recognize those modifications in a diagram.

In conclusion, regenerative feedwater heating and reheat are advanced topics compared to the basic cycles, but the FE exam expects qualitative familiarity. Always tie your explanation back to **thermal efficiency improvement** and **why it works** (in terms of averaging higher temperature heat input or preventing energy waste). Also, remember: these terms apply to **Rankine (steam) cycles** predominantly. You wouldn't talk about "reheat" in an Otto cycle context (though internally, multi-stage turbocharging with intercooling in a Diesel or multi-stage compression in Brayton are analogous concepts, but they have their own names). For the exam, keep regeneration and reheat associated with Rankine.

Topic 07 - Refrigeration and Heat Pump Cycles

Topic Introduction: Refrigeration and heat pump cycles are thermodynamic cycles that **move heat from a low-temperature location to a high-temperature location by inputting work**. In simple terms, they are **heat engines operating in reverse**. This topic matters on the FE Mechanical Exam because it covers how cooling systems (like refrigerators and air conditioners) and heating systems (heat pumps) achieve their effect, and how to quantify their performance. You'll often face questions asking you to **compute a cycle's coefficient of performance (COP)**, analyze an ideal vapor-compression cycle using property data, or compare different heat pump setups. Typical question archetypes include: calculating the COP given heat transfer and work values, reading refrigerant enthalpy from tables or a pressure–enthalpy chart to plug into energy balances, or conceptual questions about how altering conditions (e.g. using a ground-source vs. air-source heat pump) affects performance. In this chapter, we'll break down the key principles, formulas, and data skills you need to confidently handle refrigeration and heat pump cycle problems on exam day.

K11.T07.S01 – Coefficient of Performance (COP)

Principle introduction: The coefficient of performance (COP) is the primary performance metric for refrigeration and heat pump cycles. It tells you **how effectively a cycle uses work to move heat**. Unlike a heat engine's thermal efficiency (which is always less than 1), the COP can exceed 1 because the cycle transfers existing heat rather than producing work from heat. There are two COP definitions – one for cooling devices (refrigerators/AC units) and one for heating devices (heat pumps) – depending on which heat transfer is considered the useful output. A higher COP means the system delivers **more heating or cooling per unit of work input**, which is obviously desirable for energy savings. On the FE Exam, you'll use COP to evaluate refrigeration and heat pump performance; common tasks include calculating COP from given Q and W values or comparing an actual COP to the **Carnot (ideal) COP limit** to judge how efficient the cycle is relative to the theoretical maximum.

Equation Passport – Coefficient of Performance (COP)

- **Name & purpose:** *Coefficient of Performance* – measures the efficiency of a refrigeration or heat pump cycle by the ratio of heat moved to work input. It answers "**How many units of heat do we get per unit of work?**" for cooling or heating devices.

- **Equation:** For a refrigerator or air conditioner operating in cooling mode, the COP is defined as the heat extracted from the low-temperature space divided by the work input. For a heat pump (heating mode), the COP is the heat delivered to the high-temperature space divided by the work input:

$$\mathrm{COP}_{\mathrm{ref}} = \frac{Q_L}{W_{\mathrm{in}}}, \qquad \mathrm{COP}_{\mathrm{hp}} = \frac{Q_H}{W_{\mathrm{in}}}$$

where Q_L is the heat *absorbed* from the cold reservoir (cooling effect) and Q_H is the heat *released* to the hot reservoir (heating effect).

Variables & units:

- Q_L – heat removed from the low-temperature space (cooling output), in joules (J) or British thermal units (Btu).
- Q_H – heat supplied to the high-temperature space (heating output), in J or Btu.
- W_{in} – net work input to the cycle (usually the compressor work), in J or Btu.

- **COP** – coefficient of performance (dimensionless ratio, since both numerator and denominator are energy).

Assumptions & scope:

- Applies to any steady cyclic device moving heat from a cooler area to a warmer area with work input (refrigerators, freezers, air conditioners, heat pumps).

- Q_L and Q_H are **positive quantities** representing magnitudes of heat transfer. By conservation of energy for a cycle, $Q_H = Q_L + W_{\mathrm{in}}$. (All values must be in the same energy units and for the same time period or per cycle.)

- COP is valid for both **rate form** (using power $\dot{Q}, \dot{W}$) or energy per cycle – it's a ratio so the time unit cancels. Ensure consistent units (e.g. don't mix Btu/hr with watts without converting).

Limit tests (sanity checks):

- If the work input $W_{\mathrm{in}} \to 0$, then COP $\to \infty$. This would mean moving heat with no work – an unattainable ideal (it violates the Second Law). A very high COP indicates the cycle is approaching ideal behavior (Carnot limit).

- If the cycle produces no useful heat transfer (e.g. $Q_L = 0$ for a fridge that isn't cooling), then $\mathrm{COP}_{\mathrm{ref}} = 0$. No cooling output means zero performance.

- Realistic COP values are **greater than 1**. For example, a household refrigerator might have COP around 2–4, and a heat pump might be 3–5. COP being >> 1 is normal and desirable – it doesn't violate energy conservation because the extra heat is drawn from the environment.

- **Use vs. sibling formulas:** Use the COP formulas *instead of* efficiency formulas when dealing with refrigeration/heat pump cycles. **Do not confuse COP with thermal efficiency** – thermal efficiency $\eta = W_{\mathrm{out}}/Q_{H,\mathrm{in}}$ is for power-producing engines (work output over heat input). COP deals with *work input* and *heat moved*. In short, **use COP for heat movers, use efficiency for heat engines.**

Common exam traps:

- Using the wrong heat quantity: For a cooling device, always use Q_L in the numerator; for a heat pump, use Q_H. If the problem statement gives you both and you mix them up, you'll get the wrong answer. Carefully identify what the device's *useful effect* is (cooling or heating).

- Expecting COP to be < 1: Many students initially think "efficiency" and expect a number < 1. Remember, COP can be

much larger than 1. Don't be thrown off if your calculated COP is, say, 4 – that's good!

- Temperature confusion in Carnot formulas: If you use the theoretical Carnot COP equations, you **must use absolute temperatures** (kelvin or rankine). Converting 25 °C to 298 K, or 77 °F to 537 °R, is mandatory before plugging into $T_H/(T_H - T_L)$ [Always convert temperatures to an absolute scale for Carnot efficiency or COP calculations. For example, 75 °F = 535 °R. Using °F or °C directly in those formulas will give nonsense results.]. A common mistake is to use °C or °F differences directly – avoid that by converting to K or °R first.

- Unit inconsistency: Ensure Q and W use the same unit system. If heat is given in Btu and work in ft·lbf, convert one to the other (work in Btu or heat in ft·lbf) before taking the ratio, or convert both to a common power unit (like BTU/hr and horsepower, or kJ and kJ). On the exam, it's often easiest to convert everything to SI or everything to USCS and then compute COP.

Exam Handbook Search Cues (Not affiliated with or endorsed by NCEES): COP; Coefficient of Performance; refrigerator COP; heat pump COP; reversed Carnot cycle; Carnot COP

Variations, related forms, typical values: One important variant is the **Carnot COP**, which is the maximum theoretical COP for a given temperature range. For a heat pump, $\mathrm{COP}_{\text{Carnot, hp}} = \frac{T_H}{T_H - T_L}$; for a refrigerator, $\mathrm{COP}_{\text{Carnot, ref}} = \frac{T_L}{T_H - T_L}$, where T_H and T_L are the hot and cold reservoir absolute temperatures. These formulas come from the reversed Carnot cycle (the ideal frictionless, reversible cycle). They set an upper limit: *no real device can exceed the Carnot COP* for those temperatures. Because the Carnot cycle is perfectly reversible, its COP is a theoretical ceiling for operation between T_H and T_L; real devices have irreversibilities (like friction, pressure drops, heat leaks, and finite temperature differences), so their COP will always be lower. For typical real systems, COPs range from about 2 up to 5 or 6. For instance, a decent air conditioner might have COP ≈ 3 (meaning it delivers 3 kW of cooling per 1 kW of input electric power). A well-designed heat pump on a mild day can reach COP ≈ 4–5. Also note, for the **same physical device**, the heat pump COP is exactly one unit higher than the refrigerator COP at the same operating conditions. This is because $Q_H = Q_L + W_{\text{in}}$, so dividing by W_{in} gives $\mathrm{COP}_{\text{hp}} = \frac{Q_L + W_{\text{in}}}{W_{\text{in}}} = \frac{Q_L}{W_{\text{in}}} + 1 = \mathrm{COP}_{\text{ref}} + 1$. Keep that relationship in mind: if a question gives you one, you can get the other easily. Also note the cooling-capacity unit called a **"ton of refrigeration"**: **1 ton of refrigeration = 12,000 Btu/h = 3.516 kW**. This comes from the cooling effect of melting one ton of ice in 24 hours. You might see a problem that gives cooling load in tons, so you'd convert it to watts or Btu/hr to use in calculations.

Explanation & analysis: The COP formulas essentially measure **energy output (as heat moved)** per **energy input (as work)**. A higher COP means you get more heating or cooling for each joule of work put in. For example, if a refrigerator has COP = 3.0, it means for every 1 kJ of work (electricity to the compressor) you supply, it can remove 3 kJ of heat from the fridge's interior. This is possible because those 3 kJ aren't coming from nowhere – 1 kJ is from the work and 2 kJ is drawn from the fridge interior. That **moved heat** plus the work (now as heat) is dumped out the back of the fridge. This is why your kitchen gets a bit warmer when the fridge is running; the fridge is **pumping heat from inside and releasing it outside**, along with the waste work. On the exam, you'll use COP to determine how effective a cycle is or to find an unknown Q or W. The basic idea: identify which Q is the useful effect (cooling or heating), sum up energies if needed (remember $Q_H = Q_L + W$), then take the ratio.

Let's go through the formula term by term. Consider $\mathrm{COP}_{\text{ref}} = Q_L/W_{\text{in}}$. The numerator Q_L is the heat removed from the cold space (say, inside a refrigerator or the chilled water in an AC system). It has units of energy (kJ or Btu) or power (kW or Btu/hr) if dealing with rates. The larger Q_L is for a given amount of work, the better the cooling. The denominator W_{in} is the work input required, typically the compressor work in a vapor-compression cycle. This also has units of energy (kJ, Btu) or power (kW, horsepower). Because COP is dimensionless, you can use any consistent units – just be sure to match them. Physically, a high COP means the refrigerant absorbs a lot of heat in the evaporator for relatively little work input. Conversely, a low COP means you're expending a lot of work for not much cooling – an inefficient scenario often due to poor cycle design or a large temperature lift.

When using these formulas, watch out for **sign conventions**. We treat Q_L and Q_H as positive magnitudes of heat transfer *into* or *out of* the system, and W_{in} as positive work input. In a thermodynamics sign convention, the refrigerator itself has Q_L entering, Q_H leaving, and work entering. But for the purpose of COP, we just plug in the magnitudes. Another common point of confusion is mixing up which heat is which. *Tip:* Draw a quick sketch of the cycle: mark the cold space and hot space, and label Q_L at the evaporator (cold side) and Q_H at the condenser (hot side). This visual can prevent errors in selecting the right Q for the COP formula. And as mentioned, if ever you derive a COP from temperatures, remember to use absolute temperature. The Carnot COP formulas are a nice theoretical benchmark – for instance, if you calculate Carnot COP for a freezer at –5 °C exhausting to a 20 °C room, you might get a number like 10. If your actual freezer's COP is 3, you know it's about 30% of the Carnot ideal – that's typical given real-world irreversibilities.

In summary, COP is your friend in evaluating refrigeration/heat pump efficiency. Use it to compare systems or to find missing energy values. For the FE exam, problems will be straightforward plug-and-chug with COP (e.g. given Q_L and W, find COP, or given COP and W, find Q_L, etc.), or slightly conceptual (e.g. *"how can one increase the COP of an AC unit?"* Answer: lower the temperature difference it works across, maybe by using a cooler environment as the heat sink). Keep the concept and units straight, and you'll handle these questions with no sweat (pun intended).

K11.T07.S02 – Vapor-Compression Refrigeration Cycle

Principle introduction: The **vapor-compression refrigeration cycle** is the standard cycle underlying most refrigerators, air conditioners, and heat pumps. It has four key components (and processes) that form a closed loop: **evaporation, compression, condensation, and expansion**. In the evaporator, the refrigerant takes in heat from the space being cooled and boils from liquid to vapor at low pressure and temperature. The compressor then does work on this vapor, **raising its pressure and temperature** (usually an **adiabatic compression** – ideally isentropic). Next, in the condenser, the hot refrigerant at high pressure rejects heat to the surroundings (air or water) and condenses from vapor to liquid at approximately constant high pressure and temperature. Finally, the high-pressure liquid passes through an expansion device (throttle valve or capillary tube), which **lowers its pressure (an iso-enthalpic expansion)** and thus its temperature, partially vaporizing it into a cold mixture of liquid/vapor. That cold mixture then enters the evaporator to pick up heat again, and the cycle repeats. This cycle is essentially a **"reversed heat engine"** – instead of producing work from a heat difference, we consume work to pump

heat **against** its natural flow direction (cold to hot). Key performance measures for this cycle include the COP (covered above), the **cooling capacity** (how much heat it can remove, sometimes given in tons or BTU/hr), and factors like compressor work or refrigerant mass flow needed for a given cooling load. On the FE Exam, you may be asked to identify states in the cycle (e.g. "point 3 is after the compressor, what happens here?") or to calculate values like Q_L, Q_H, or W_{in} given enthalpies at various points. You could also encounter questions requiring you to use the refrigeration cycle property charts or tables to find those enthalpies (linking to the next subtopic on refrigerants data).

Footnotes:

- Refrigeration cycles assume **steady-state** operation and usually neglect changes in kinetic or potential energy of the flow. Each component (evaporator, compressor, etc.) is analyzed as a steady-flow device (SFEE application).

- In the **ideal cycle** (often assumed for FE problems unless stated otherwise), the compression is **isentropic** (no entropy generation, reversible adiabatic), the condenser and evaporator deliver **constant-pressure heat exchange** (refrigerant is saturated during most of these processes, so temperature remains nearly constant while heat is added or removed), and the expansion is a simple throttle (iso-enthalpic, highly irreversible, no work extracted). Real systems have inefficiencies (non-isoentropic compression, pressure drops, etc.), but these are usually beyond the scope of FE exam unless qualitatively mentioned.

- Because the expansion process in a typical vapor-compression cycle is done through a throttle (like an expansion valve) and not a turbine, no work is recovered during expansion – it's wasted potential work. This is a design trade-off: expansion devices are cheap and reliable, whereas an expanding turbine to recover work would be complex/costly and is only used in special systems.

- **Pressure levels:** The evaporator operates at a low pressure (corresponding to the low temperature T_L), and the condenser operates at a high pressure (corresponding to T_H). The compressor takes suction at the evaporator pressure and discharges at the condenser pressure. These pressure levels are determined by the chosen refrigerant and the desired temperatures. For example, using R-134a to achieve an evaporator at –10 °C and a condenser at 40 °C means roughly suction pressure ~ 150 kPa and discharge ~ 1000 kPa (just an illustration – see refrigerant tables for exact values). Always think: low side vs high side of the system.

Variations, related forms, typical values: The single-stage vapor-compression cycle described above is the most common, but there are variations for improved performance in certain situations:

- **Multi-stage refrigeration cycles:** If you need a large temperature lift (say, –40 °C freezer to 30 °C ambient), a single compressor might struggle. **Two-stage refrigeration** cycles with an intermediate cooler are used to achieve lower temperatures efficiently. The FE Handbook mentions two-stage refrigeration and *air* refrigeration cycles. Two-stage vapor-compression uses two compressors in series (or a two-stage compressor) and often an intercooler or flash chamber to improve COP when the temperature span is large.

- **Air refrigeration cycle:** This is essentially a reversed Brayton cycle (using air as the working fluid, compressed and expanded usually in turbines). It's less efficient than vapor-compression for most applications, but it's used in aircraft cooling (where air is readily available, weight is critical, and very low temperatures might not be needed). If the exam asks about an "air-cycle machine," remember it uses an open cycle taking air from atmosphere, compressing it, cooling it, then expanding to yield cooling. It typically has a lower COP compared to a Freon cycle.

- **Typical operating conditions:** A household refrigerator might operate with an evaporator at ~–20 °C (to keep freezer ~–15 °C) and a condenser at ~40 °C (room temp). An air conditioner might evaporate at ~5 °C (to dehumidify air) and condense at ~50 °C on a hot day. These translate to certain pressures depending on refrigerant. The **cooling output** (capacity) can vary widely: small fridge ~100 W, home AC ~3–5 kW (1–1.5 ton), large commercial chiller hundreds of kW. The **compressor work** is typically 1/3 to 1/5 of the heat moved (hence COP 3–5). Knowing these orders of magnitude can help sanity-check your answers (e.g., if you calculate a compressor power higher than the cooling load, something's off because that'd be COP < 1, essentially an electric heater!).

Special notes (calculator tips): When solving numerical vapor-compression cycle problems:

- Organize known properties at each state 1–2–3–4. It helps to sketch the cycle diagram (even a simple box diagram: evaporator -> compressor -> condenser -> expansion -> back to evaporator) and label state points. This prevents mixing up states.

- The exam's reference handbook provides property tables and *sometimes a Mollier diagram (P–h chart)* for refrigerants. If a problem gives you two properties for a state (like pressure and temperature), use the **exam handbook's refrigerant tables** to retrieve enthalpy or entropy. Practice reading those tables quickly – know that saturated states can be found by either temperature or pressure lookup.

- If a state is described as "saturated vapor at –10 °C" (for example), you know the quality x = 1 and you should grab h_g and s_g for –10 °C from the table. If it says "20% quality" at a certain pressure, you'll interpolate: $h = h_f + 0.20(h_g - h_f)$ (more on that in the next subtopic).

- Be careful with units: The refrigerant tables might use Btu/lb and psia (for USCS) or kJ/kg and kPa (for SI). Convert your work input to the same unit basis if needed. For instance, if you compute compressor work in kJ/kg and find refrigerant enthalpies in kJ/kg, COP will be dimensionless correctly. If using Btu/lb, that works too. Just don't mix J with Btu or lb with kg inadvertently.

Explanation & analysis: Let's walk through the ideal vapor-compression cycle step by step, focusing on what each part does and the energy analysis. Using the usual numbering from the diagram: **state 1** is the evaporator outlet (low-pressure vapor), **state 2** is the compressor outlet (high-pressure superheated vapor), **state 3** is the condenser outlet (high-pressure liquid), and **state 4** is downstream of the expansion valve (a low-pressure liquid–vapor mixture).

Process 1–2: Compression. The refrigerant vapor entering the compressor is cold and low pressure (state 1). The compressor adds work to it, compressing it to a higher pressure. For an ideal (isentropic) compressor, no heat is lost, and entropy stays constant ($s_1 = s_2$). The temperature skyrockets during this process – the vapor coming out (state 2) is much hotter than the surroundings (it might be superheated). Energy-wise, the work W_{in} input is absorbed by the refrigerant as increased internal energy (and some flow work), raising its enthalpy from h_1 to h_2. On a T–s diagram, this is a vertical line upward. On a P–h (pressure-enthalpy) chart (often used

by HVAC engineers), compression shows as a steep upward curve (pressure up, enthalpy up). The work input per unit mass is $h_2 - h_1$. A common exam question is to calculate compressor work given enthalpies: just take the difference $h_2 - h_1$.

Process 2–3: Condensation (Heat Rejection). The hot, high-pressure refrigerant vapor now enters the condenser, which is basically a heat exchanger coil exposed to ambient air (or cooling water). Heat flows from the refrigerant to the cooler ambient. The refrigerant first cools to its saturation temperature at that pressure (if it was superheated) and then **condenses to liquid**. During condensation, the temperature remains constant at T_H (for a pure substance condensing at constant pressure). By the end, at state 3, the refrigerant is a high-pressure **saturated liquid** (or subcooled liquid if further cooled). The amount of heat removed in the condenser is Q_H (released to the environment). From energy balance, $Q_H = h_2 - h_3$ (per unit mass), since the enthalpy decreases from h_2 to h_3. This heat is what a heat pump would use to warm your house, or in an AC, it's the waste heat dumped outside. Physically, you can often feel this: the condenser coil or the back of your fridge is warm – that's Q_H being released. On the T–s diagram above, 2→3 is a move leftwards at roughly constant T (horizontal line at T_H as vapor turns to liquid). On a P–h diagram, 2→3 is a line going left (enthalpy dropping) at constant high pressure.

Process 3–4: Expansion (Throttling). Now we have high-pressure liquid refrigerant at state 3. To get it back down to the evaporator pressure, it passes through an expansion valve or capillary tube. This process is **adiabatic** (no heat exchange, it's a short insulated flow restriction) but extremely irreversible. The pressure drops from condenser pressure down to evaporator pressure. The refrigerant *partially vaporizes* (flashes) as it cools down to the lower saturation temperature. Importantly, **enthalpy stays constant** ($h_3 = h_4$) through an ideal throttle (isoenthalpic process). This is a key point: if you know h_3, you immediately know h_4 for an ideal expansion valve. The entropy increases ($s_4 > s_3$) because of the irreversible nature of throttling. After expansion, at state 4, the refrigerant is a low-pressure cold mixture of liquid and vapor (generally a high quality liquid-vapor mix, mostly liquid). It's cold enough to absorb heat in the evaporator. On the diagrams, 3→4 is vertical on P–h (constant enthalpy) and drops down on T–s (with a slight move to the right indicating entropy generation). No work is done (or extracted) in this process – it's just a drop in pressure and temperature.

Process 4–1: Evaporation (Heat Absorption). Finally, the cold mixture enters the evaporator coil, which is in the space to be cooled (like inside a fridge or the cooling coil in an AC air handler). Here, the liquid refrigerant absorbs heat from that space and **completely boils into vapor** by the end of the evaporator. The pressure remains at the low evaporator setting, and the temperature stays around T_L (as long as there's some liquid present, boiling keeps the temp roughly constant). By state 1, ideally we have saturated vapor (x=1) at low pressure, ready to go into the compressor again. The heat absorbed Q_L equals $h_1 - h_4$ (how much the enthalpy increased as the refrigerant went from cold liquid mix to vapor). This Q_L is the useful cooling effect: it's what chills your food or your room. In the T–s diagram, 4→1 is a horizontal line at T_L moving to the right (increasing entropy as liquid evaporates into vapor). On a P–h chart, 4→1 is a line to the right at constant low pressure.

Overall, the **energy balance for the whole cycle** (combining these steps) is $Q_H = W_{\text{in}} + Q_L$. The first law for a cyclic process tells us that the net work input equals net heat output (with sign conventions); here the system receives net work W_{in} and dumps net heat $Q_H - Q_L$ to the environment. Rearranging, $Q_H = Q_L + W_{\text{in}}$. This makes intuitive sense: the heat dumped to the high side is just the sum of heat absorbed from the low side plus the work added by the compressor. This relation is also why, as mentioned earlier, a heat pump's COP is one plus the refrigerator's COP for the same cycle.

From a problem-solving perspective, analyzing a refrigeration cycle usually means applying the first law to each component (as we just qualitatively did) and using property data for the refrigerant to find enthalpies. A typical exam problem might give you the refrigerant type and some conditions: e.g., "R-134a enters the compressor as saturated vapor at –10 °C, and leaves at 1 MPa. It then condenses at 1 MPa to saturated liquid. Calculate the COP." You would: (1) get h_1 for R-134a at –10 °C, sat. vap; (2) get h_3 for R-134a at condensing pressure (1 MPa) sat. liquid; (3) assume an ideal compressor to get h_2 (here you might need to find isentropic enthalpy at 1 MPa using entropy from state 1 – or the problem might simplify and give h_2 directly or assume reversible so that you use h_2 as sat. vapor at 1 MPa plus superheat info); (4) know $h_4 = h_3$ (throttling); then compute $Q_L = h_1 - h_4, W_{\text{in}} = h_2 - h_1, Q_H = h_2 - h_3$. Finally, $\text{COP}_{\text{ref}} = \frac{h_1 - h_4}{h_2 - h_1}$. If any of these values are given, you can solve for the unknown. Always double-check units and that your enthalpy values make sense (vapor enthalpy > liquid enthalpy, etc.).

The vapor-compression cycle is highly efficient for cooling duties, which is why it's everywhere from your kitchen to industrial chillers. Remembering the sequence of processes and their purpose will help you tackle both conceptual and calculation questions. And keep in mind the big picture: the **compressor** is the only part that consumes work; everything else is just moving heat around. If you understand that, you can derive or check most of the relationships in the cycle.

K11.T07.S03 – Refrigerants and Property Tables/Charts

Principle introduction: "Refrigerant" is the name for the working fluid that **circulates through a refrigeration cycle**, undergoing phase changes to absorb and release heat. Good refrigerants have appropriate boiling points, high latent heat, favorable pressures, and chemical stability (and nowadays, low environmental impact). Common examples include **R-134a** (1,1,1,2-Tetrafluoroethane), used in many car AC and older domestic fridges, and **R-410A** (a blend of R-32 and R-125), used in newer home AC systems. The FE Exam expects you to use **refrigerant property tables and charts** to find thermodynamic properties at various states. In the exam's reference handbook, you'll find tables for saturated liquid/vapor properties of R-134a and R-410A, and even a Pressure–Enthalpy (P–h) diagram for R-134a. These are there to help you avoid memorizing refrigerant data – instead, you need to practice reading them. Typically, a problem might give you a refrigerant state (like "saturated vapor at 40 °F" or "quality = 0.4 at 20 psia") and you'll have to retrieve values like enthalpy (h), entropy (s), temperature (T), or specific volume. Sometimes you'll interpolate between entries if the exact value isn't tabulated. Another common task is recognizing the phase: e.g., if given pressure and enthalpy, you might use the chart to deduce that the state is superheated or two-phase. Understanding refrigerant tables and charts is crucial for analyzing cycles: it enables you to calculate Q_L, Q_H, and W by finding h values at key points. This subtopic focuses on how to effectively use these references on exam day.

Table Passport – Refrigerant Saturation Properties

- **Table title and purpose:** *Saturated Refrigerant Property Table* – This table lists the thermodynamic properties of a refrigerant at saturation conditions. Typically, one side is indexed by temperature and the other by pressure (they're two ways of identifying the same saturation states). For each temperature (or pressure), you get the corresponding saturation pressure (or temperature), and the values of **liquid** (often subscript f) and **vapor** (subscript g) properties: specific volume (v), internal energy (u) if given, enthalpy (h), entropy (s), etc., for the saturated liquid and saturated vapor. The table helps you find properties for saturated liquid, saturated vapor, or saturated mixtures at a given condition. It's basically your menu of data for states where liquid and vapor coexist in equilibrium.

- **How to read and interpolate:** If a problem gives you a saturation temperature or pressure, you directly locate that entry. For example, "R-134a at –10 °F saturated vapor" – go to the R-134a table, find –10 °F in the temperature column, and read off h_g (enthalpy of vapor) and s_g, etc. If the exact temperature isn't listed, you may need to **interpolate linearly** between two rows. Similarly, if given pressure (say 50 psia), use the pressure-indexed part of the table. For **quality** x (the fraction vapor in a saturated mixture), you'll interpolate between liquid and vapor values at that saturation condition. The formula is: for any property Φ, $\Phi_{\text{mix}} = \Phi_f + x(\Phi_g - \Phi_f)$. For instance, if at 20 psia R-134a, $h_f = 40$ Btu/lb and $h_g = 100$ Btu/lb, and quality x=0.25, then $h_{\text{mix}} = 40 + 0.25(100 - 40) = 55$ Btu/lb. **Do not** extrapolate beyond the table range; if a state is outside the saturation range (e.g., a temperature above the boiling point for a given pressure), it means the refrigerant is superheated or subcooled – you'd need superheated tables or other data (in the exam, likely you'll be dealing mostly with saturated states or given enough info to avoid extensive superheated table use).

- **Units and source info:** Pay attention to units! The exam reference might provide refrigerant tables in both SI and USCS units. For example, the R-134a table might list temperature in °F, pressure in psia, enthalpy in Btu/lb, entropy in Btu/(lb·°F). The R-410A table could be similar. If you see a number like "101.39" in an enthalpy column with units Btu/lb, that's a small amount of energy per mass (101 Btu per pound is 235.3 kJ per kg if you convert). Don't mix up units – if you're more comfortable in SI, consider converting the needed values to SI (the handbook might also have an SI version of the table). The tables in the exam handbook are adapted from sources like ASHRAE data, but you do **not** need to memorize any of those numbers – just know how to fetch and use them.

- **Typical exam uses:**

- **Determine phase or quality:** Given two properties, you might identify the state. E.g., "Refrigerant at 40 psia has enthalpy 50 Btu/lb" – check saturation at 40 psia: if 50 is between h_f and h_g, the fluid is a mixture with a certain quality; if 50 is approximately h_f or h_g, it's saturated liquid or vapor; if it's outside that range, it's subcooled liquid or superheated vapor.

- **Find enthalpy/entropy for energy calculations:** Most often, you'll lookup enthalpies for states 1, 3, 4 (and maybe 2 if superheat info given) in a cycle to then plug into $Q = h_{\text{out}} - h_{\text{in}}$ or COP formulas. For instance, "What is the refrigerating effect (in Btu/lb) for R-134a operating at $-20°$Fevaporator and $100°$Fcondenser?" You'd get $h_1 = h_g\,|_{-20°\text{F}}, h_4 = h_f\,|_{-20°\text{F}}$ (if throttling to saturated mixture at evaporator inlet, quality ≈ 0), so $Q_L = h_1 - h_4 = h_g - h_f$at $-20°$F.

- **Use pressure–enthalpy (P–h) chart:** The handbook provides a P–h diagram for R-134a which can graphically give you state properties. On such a chart, you can locate a state given pressure and enthalpy (the coordinates of the chart), then read other info like temperature or quality lines. This is useful if, say, state 2 is superheated – you could find where it lies on the chart by intersection of a pressure line and an enthalpy value, and see the temperature or entropy. The P–h chart also nicely shows processes: vertical line for throttling (constant h), nearly vertical curve for compression (increasing h and P), horizontal line for isothermal condensation, etc. If an exam question is more conceptual, they might ask something like "On a P–h diagram of a refrigeration cycle, which process is a vertical line?" (Answer: the expansion, because enthalpy is constant). So being familiar with the diagram's layout can pay off.

- **Common pitfalls:**

- **Mixing up refrigerants or tables:** Ensure you're using the correct table for the refrigerant in the problem. R-134a and R-410A have very different properties (410A operates at much higher pressures for the same temperatures, for instance). The exam may specify the refrigerant; turn to that table. If you accidentally use the wrong table, your numbers will be way off.

- **Misreading saturated vs superheated data:** The provided tables in the FE Reference are mostly for saturated conditions. If a state is superheated (temperature > saturation temp at that pressure), don't use the saturated vapor values blindly – the actual enthalpy will be higher. The exam might give you enough info to avoid needing a separate superheated table (or they might give superheat values explicitly). But be cautious: for example, "R-134a at 100 psia and 70°F" – check saturation: at 100 psia, sat temp is around 88°F (just hypothetical). 70°F is below that, so actually that would be subcooled liquid (70°F liquid at 100 psia). If you mistakenly take saturated values at 100 psia (which correspond to 88°F), you'd be using wrong data. So always cross-check: pressure + temperature given → compare to saturation temperature. If $T_{\text{given}} < T_{\text{sat}}(P)$, it's subcooled liquid; if $T_{\text{given}} > T_{\text{sat}}(P)$, it's superheated vapor; if equal (or problem explicitly says saturated), then it's on the saturation curve.

- **Interpolation errors:** Linear interpolation is usually fine for small gaps, but be careful to interpolate the correct values. A common mistake is to interpolate with respect to the wrong column. For instance, if you need h at 37°F but have 35°F and 40°F in the table, interpolate between the h values at those temps. Don't try to do something weird like interpolating pressure then using that to get enthalpy – just interpolate in the property of interest directly since the change is roughly linear over small ranges. And **do not extrapolate** beyond the table's ends (e.g., wanting data below the lowest temperature or above the highest pressure). If a state is outside the given range, the problem likely expects you to recognize it as either ideal gas or something qualitative.

- **Forgetting units conversion:** The table might give entropy in Btu/(lb·°F). If you're plugging into an equation that needs entropy in, say, Btu/(lb·°R) (less likely) or comparing with SI values, be mindful. Usually, stick to what the table gives. Similarly, specific volume might be in ft³/lb – if the problem expects an answer in m³/kg, convert accordingly (1 ft³/lb = 0.0624 m³/kg approximately, since 1 lb = 0.4536 kg and 1 ft³ = 0.0283 m³). Most exam problems will be set up so you can stay in one unit system throughout – just keep an eye on that.

- **Data hunting under time pressure:** The exam is computer-based, so you'll be searching the PDF for these tables. Knowing **keywords** helps: search "Refrigerant 134a" or "Properties of Saturated" to jump to the right page quickly. We listed some

keywords below. Don't waste time scrolling page by page. Also, note that the tables are likely condensed; find the exact temperature or pressure entry carefully (some tables list every 5 degrees, etc.). It's easy to mis-read a value from an adjacent line or column if you're rushing, so use a ruler (or the highlight cursor) to track the row. Small errors in reading values can lead to wrong answers.

Exam Handbook Search Cues (Not affiliated with or endorsed by NCEES): R-134a; Refrigerant 134a; Refrigerant 410A; pressure-enthalpy chart; saturated liquid; saturated vapor; quality x; saturation table

Explanation & analysis: The refrigerant is the *lifeblood* of the refrigeration cycle – it's what carries energy around by changing phase. On the exam, once you conceptualize the cycle, most numerical answers will come from **plugging in property values** from the tables or charts. Let's say a problem involves R-134a. You might be told: "State 1: saturated vapor at –20 °C. State 2: compressed to 800 kPa. State 3: saturated liquid at 800 kPa. State 4: throttled back to –20 °C." To find the COP, you need h_1, h_2, h_3, h_4. How to get them?

Using tables: For state 1 (sat. vapor at –20 °C), go to R-134a table at –20 °C, vapor enthalpy h_g is what you need. For state 3 (sat. liquid at 800 kPa), find the saturation temperature corresponding to 800 kPa (or find 800 kPa in the pressure table) – let's say that's about +15 °C (just example). Take h_f at that pressure. State 4 after throttling has $h_4 = h_3$ (isoenthalpic), so that's already known. State 2 (after isentropic compression) is a bit trickier: if we assume isentropic, you'd use the entropy. $s_1 = s_g$ at $-20°\text{C}$. That same entropy at 800 kPawill give you state 2's properties – you'd likely have to look at a superheated table or chart, or an ideal gas approximation if superheat is high. This is where the **Mollier chart (P–h diagram)** is handy: you'd mark 800 kPa and move along a line of constant entropy equal to s_1 until you hit 800 kPa. The enthalpy at that intersection is h_2. If the exam doesn't provide superheat data, sometimes they simplify by saying the compressor exit is still saturated vapor at the condenser pressure (which isn't physically realistic, but makes it easier to take $h_2 = h_g$at that pressure). Read the problem carefully to see what assumptions to use.

Pressure–Enthalpy (P–h) chart usage: This chart (given for R-134a in the handbook) is essentially a map of all possible states. Pressure is on a logarithmic vertical axis, enthalpy on horizontal. Lines of constant temperature, constant entropy, and quality are plotted. If you have any two properties, you can find the state. For example, say a state is "R-134a at 0 °F with h = 50 Btu/lb." You could go to the R-134a P–h chart (USCS units), find the 0 °F temperature line, and see where the enthalpy ~50 crosses it. If 50 is less than h_f at that temp, that state might actually be subcooled liquid (since at sat. liquid maybe h_f is higher). If it's between h_f and h_g, that point on the 0 °F line lies under the saturation dome – meaning it's a mixture with some quality (you could estimate quality by seeing how far between liquid and vapor it is). The P–h chart is great for visualizing the entire cycle: you can literally draw the 1-2-3-4 cycle and read off approximate enthalpies and entropies. However, keep in mind in an exam situation, using the chart might be a bit time-consuming unless you've practiced it; reading exact values off a small chart can be less accurate than using the precise tables. The chart is more for conceptual understanding or quick estimates. The FE might include it to test conceptual reading (like "which segment represents the evaporator process?" or "what does point inside the dome represent?"). A point inside the dome is a saturated mixture (quality between 0 and 1). A point on the left border is saturated liquid, on the right border is saturated vapor. A vertical move on this chart means constant enthalpy (throttle), a horizontal move means constant pressure (assuming horizontal alignment, though pressure is vertical axis on this particular chart, so careful: on P–h, horizontal means change in enthalpy at constant pressure is actually a horizontal line segment; a vertical move means changing pressure at constant enthalpy). So, memorize: on a P–h diagram, **throttling = vertical line (P drops, h const)**, **compression = up-and-left (P increases, h increases)**, **condensing = leftwards at top pressure**, **evaporating = rightwards at bottom pressure**.

Choosing data and performing calculations: When you have the needed property values from the tables/charts, plug them into your formulas. For example, to get Q_L(per mass), do $h_{\text{evap,out}} - h_{\text{evap,in}} = h_1 - h_4$. To get COP, do $\text{COP} = \frac{h_1 - h_4}{h_2 - h_1}$.

Make sure you correctly identify h_4. If state 4 is after expansion, a common simplification is to assume it's a saturated mixture entering the evaporator with quality $x = 0$(i.e., all liquid, just at evaporator temperature), or sometimes quality a bit above 0. In an ideal cycle, if we assume no subcooling in the condenser, then $h_3 = h_f\,|_{T_H}$. After throttling, $h_4 = h_3$.

If that value equals $h_f\,|_{T_L}$, it means it expanded to just saturated liquid at the evaporator inlet ($x = 0$). Often, however, $h_4$will be higher than $h_f\,|_{T_L}$, meaning a bit of vapor formed ($x > 0$). In any case, $h_1 - h_4$would equal $h_g\,|_{T_L} - h_{\text{mix}}\,|_{T_L}$.

If $h_4 = h_f\,|_{T_L}$, then $Q_L = h_g - h_f = h_{fg}$at T_L. We mention this because sometimes exam questions use the latent heat directly (which is h_{fg}). Like, "latent heat of R-134a at $-20°$Cis X kJ/kg, find mass flow to achieve Ycooling." You'd use that h_{fg}as the cooling per kg. Remember, $h_{fg} = h_g - h_f$.

Environmental notes (conceptual, likely not tested): Modern refrigerants are chosen for zero ozone depletion potential (ODP) and low global warming potential (GWP). Old ones like R-12 (CFC) were banned for harming ozone. R-134a (an HFC) has zero ODP but some GWP, now being replaced in cars by R-1234yf (very low GWP). R-410A has zero ODP but high GWP, future might see R-32 or CO_2 (R-744) in some systems. *It's unlikely the FE exam goes into this environmental aspect,* but it's good engineering context. If anything, they might throw a general question like "which of these is an environmentally friendly refrigerant?" – answer might be ammonia (natural but toxic), CO_2, or newer HFOs. However, since the exam provides specific tables for R-134a and R-410A, those are your focus for calculation problems.

In summary, to excel in this subtopic: **practice using the refrigerant tables** – know what each column means and how to pick the right values. When you see a state description, break it down: is it sat. liquid, sat. vapor, or mixture? Use quality formula if needed. Use the P–h diagram for conceptual insights, but rely on tables for numeric precision. And double-check units to avoid a silly mistake. With these skills, you'll handle any refrigeration property lookup or cycle analysis that the FE can throw at you.

K11.T07.S04 – Heat Pump Cycle (Heating Mode and Sources)

Principle introduction: A **heat pump** is essentially a refrigeration cycle run for the purpose of heating a space rather than cooling. In hardware terms, it's the same vapor-compression cycle: evaporator, compressor, condenser, expansion device. The only difference is our perspective on which heat is the "useful output." For a heat

pump, the useful heat is Q_H – the heat released at the condenser – which is used to warm an environment (your house, for example). The heat pump's evaporator is placed outdoors (or in a cold source) to absorb heat Q_L from the surroundings (even if it's cold outside, there's still thermal energy to pick up). The cycle then pumps that heat indoors and adds the compressor work, delivering a larger Q_H inside. Heat pumps matter because they can provide **space heating far more efficiently than electrical resistance heaters** – since they move heat instead of just converting work to heat, you can get 3-5 kWh of heat into your home for every 1 kWh of electricity used. On the FE Exam, you should understand that a heat pump *is the same cycle as a refrigerator*, just serving a heating purpose. Therefore, all the formulas from refrigeration apply, just swapping which Q we care about. You might get conceptual questions like "What happens to heat pump performance as outside temperature drops?" or "Compare ground-source vs air-source heat pumps." You could also be asked to calculate COP of a heat pump (using $\mathrm{COP_{hp}} = Q_H/W$) or relate it to the COP of the same system used for cooling.

Definition/Note Passport – Heat Pumps (Heating Mode vs. Cooling Mode)

- **Plain-language definition:** A *heat pump* is a device that heats a space by **pumping heat from a colder region to a warmer one** using mechanical work. It's literally a refrigerator in reverse – instead of cooling an interior and dumping heat outside, it cools the outside (or ground) a bit and dumps heat *into* the interior. In heating mode, the "condenser" coil is indoors releasing heat, and the "evaporator" coil is outdoors absorbing whatever heat it can from the environment. A heat pump's symbol $\mathrm{COP_{hp}}$ denotes how effectively it uses work to deliver heat. Heat pumps often have a reversing valve, so they can act as an AC in summer (same cycle, just swap which coil is doing what).

- **Where it matters (exam impact):** You might see questions about heat pump efficiency or comparing it to other heating methods. For instance, a common question: *"An electric resistance heater has 100% efficiency (1 kW in gives 1 kW heat). A heat pump has COP = 3.5. How many kW heat do you get per kW electric? Which is better?"* Obviously, the heat pump giving 3.5 kWheat per kW input is better (assuming moderate climate). Another scenario: calculating $\mathrm{COP_{hp}}$ given data, or asking what happens to $\mathrm{COP_{hp}}$ if the outdoor temperature changes. Also, conceptual understanding of **ground-source vs air-source** heat pumps can appear: e.g., *"Why do ground-source heat pumps have higher COP than air-source?"* Or maybe *"Which type works better in cold climates?"*

- **Pitfall or confusion point:** Don't get confused between COP for cooling vs heating. If a problem statement says "heat pump COP," they mean $\frac{Q_H}{W}$. If they say "refrigerator COP" or just "COP" in context of cooling, they mean $\frac{Q_L}{W}$. Also, remember the relationship $\mathrm{COP_{hp}} = \mathrm{COP_{ref}} + 1$ (for the same device operating between the same two temperature reservoirs). This often catches students by surprise – it comes directly from energy balance. Another confusion could be units: COP is still dimensionless. Sometimes heat pump performance is given in other terms like HSPF (Heating Seasonal Performance Factor) or COP on a specific scale, but for exam purposes COP is straightforward. Finally, ensure you interpret wording: if a question says "a heat pump is used to maintain a house at 70°F by extracting heat from 35°F air," $T_H = 70°F(inside)$ and $T_L = 35°F(outside)$ but use absolute in formulas if needed.

- **Micro-check:** True or False? *"A heat pump's COP can be greater than 1, meaning it delivers more heat than the work input."* – **True.** In fact, it must be >1 to be worthwhile (typically 2–4 or more), because it's moving heat from outside plus adding work. This is unlike a pure electric heater which has COP = 1 (1 unit of work becomes 1 unit of heat). If you ever calculate a heat pump COP less than 1, something's wrong (or the scenario is extremely unfavorable, like trying to suck heat from -30°C air, at which point the device isn't effective).

Now, speaking of **ground-source vs air-source**: A *ground-source heat pump* (also called a geothermal heat pump) uses the ground (or groundwater) as the source (in winter) or sink (in summer) for heat. The ground a few feet down stays at a relatively moderate temperature year-round (often around 50–60 °F or 10–16 °C in many climates). In winter, that means the heat pump is drawing heat from a ~55 °F source instead of frigid 20 °F air – **much easier** because the temperature lift is smaller. In summer, it dumps heat into 55 °F ground instead of 90 °F air – again easier. Thus, ground-source heat pumps tend to have **higher COPs** consistently. An *air-source heat pump* uses outside air as the source/sink. It's simpler (just an outdoor unit with a fan) and cheaper to install, but the performance drops when the outside air gets very cold (because extracting heat from 0 °F air is hard – the COP falls, and at some point auxiliary electric heaters might be needed to meet demand). On a moderate day, both types work, but in extremes, ground-source shines. The FE exam could ask, for example, *"Which system is more efficient for heating in cold climates?"* – answer: ground-source heat pump, due to higher source temperature leading to higher COP. Or a theoretical question: *"All else equal, what happens to heat pump COP as the temperature difference between inside and outside increases?"* – it **decreases** (approaches 1 as difference grows, meaning you lose the advantage).

To relate to formulas, consider Carnot COP. If inside T_H and outside T_L: Carnot $\mathrm{COP_{hp,max}} = \frac{T_H}{T_H - T_L}$. Suppose inside is 295 K (22 °C), outside ground is 285 K (12 °C), then ideal COP = 295/(10) = 29.5 (huge!). If outside air is 255 K (–18 °C), then COP = 295/(40) = 7.4. Real heat pumps operate at a fraction of Carnot, but the ratio gives you an idea. Ground-source (small $T_H - T_L$) yields a high theoretical COP, whereas a big $T_H - T_L$ (very cold air) yields a lower theoretical COP. So qualitatively: **the smaller the temperature lift, the better the COP** – that's why using the ground or a body of water (which is warmer than winter air, cooler than summer air) helps performance a lot.

One more note: Heat pumps are often rated by coefficients of performance at standard conditions (like COP at 47°F outdoor, etc.) and by HSPF (Heating Seasonal Performance Factor) which is a seasonal average. But FE won't dive into those specifics. Just know COP is instantaneous performance.

In exam problems, treat heat pump calculations the same as refrigerator calculations except ensure you focus on Q_H. For example, if a problem says "A heat pump delivers 30,000 Btu/hr of heat to a house for an input of 2.5 hp. What is its COP?" First, convert 2.5 hp to Btu/hr: 1 hp = 2545 Btu/hr (approximately). So 2.5 hp = 6363 Btu/hr (approx). COP_{hp} = (heat out)/(work in) = 30000 / 6363 ≈ 4.7. That's a plausible COP. If the same device were cooling (AC mode), its COP_{ref} would be 4.7 – 1 = 3.7 (since the cooling output would be 30000 – 6363 = 23637 Btu/hr for the same work, presumably). These relations hold as long as it's the identical operating conditions in reverse.

Finally, think of a heat pump as an energy multiplier: it **uses one unit of work to move multiple units of heat**. Ground vs air source

is just about how hard it has to work for those multiple units. Installation-wise, ground-source requires burying long loops of pipe (expensive upfront), whereas air-source just sits outside (cheaper). But exam won't quiz cost – just performance.

In summary, **heat pumps are just "heaters" that use the refrigeration cycle.** They are efficient in moderate climates and even in cool climates up to a point. Know the COP formula and that relationship to refrigeration COP, and remember that any insight from refrigeration applies here too (just swap perspective). If a question contrasts ground vs air, emphasize the temperature difference argument. And always keep track of which Q you're dealing with: Q_H for heating mode (house heating), Q_L for cooling mode (refrigeration). With that straight, you'll pump through those questions with no trouble.

Topic 08 - Nonreacting Mixtures of Gases

Topic Introduction: Nonreacting gas mixtures are common in mechanical engineering scenarios—from standard air (a mix of gases) to combustion products and HVAC air-vapor systems. On the FE Mechanical Exam, you'll encounter questions where you must find a mixture's pressure, effective gas constant, or moisture content.

The typical question archetypes include:

- **Partial pressure problems:** using Dalton's law to compute one gas's pressure or a total pressure in a tank with multiple gases.
- **Mixture property calculations:** finding a mixture's average molecular weight, specific gas constant, or specific heat given its composition. - **Psychrometric (moist air) questions:** determining humidity ratio, relative humidity, or dew point for air–water vapor mixtures (important in HVAC contexts).

Understanding ideal gas mixture principles ensures you can quickly identify the right formula (and *where to find it in the exam handbook*) and avoid common pitfalls with units and definitions on exam day. Let's break down the subtopics and their core formulas.

K11.T08.S01 – Dalton's Law of Partial Pressures

- **Principle introduction:** In an ideal gas mixture, each component gas behaves as if it alone occupies the volume – contributing a *partial pressure*. **Dalton's law** states that the mixture's total pressure equals the sum of the individual partial pressures. This works because ideal gases don't interact chemically or significantly physically (no forces between molecules). Think of it as each gas being an ideal "roommate" – it occupies the shared space without bothering the others, so their pressures simply add up. This law lets you solve multi-gas problems by treating one gas at a time and summing up results.

Equation Passport: Dalton's Law of Partial Pressures – calculates the total pressure of an ideal gas mixture from individual gas contributions.

Formula:

$$P_{\text{total}} = \sum_{i=1}^{n} P_i,$$

where each P_i is the partial pressure of gas component i.

Variables (and units):

- P_{total} – total pressure of the gas mixture (Pa, psi, atm – **absolute** pressure).
- P_i – partial pressure of component i (same units as P_{total}, absolute).
- n – number of gas species in the mixture (unitless count).
- *Related:* x_i – mole fraction of component i (dimensionless). By ideal gas behavior, $P_i = x_i\, P_{\text{total}}$. (Volume fraction equals mole fraction for ideal gases.)

Assumptions & scope:

- The gases are **ideal** (valid at low to moderate pressures where intermolecular forces are negligible). All components share the same T and V (well-mixed, in equilibrium).
- Pressures are measured on an **absolute** scale. Dalton's law is applied using absolute pressures (e.g. in Pa or atm). *Gauge pressures cannot be directly summed.*
- The mixture is **nonreacting** – no chemical reactions or phase changes among components while applying this law.

Limit checks (sanity tests):

- If one component is removed ($P_i \to 0$), the total P_{total} decreases by that amount. (No mysterious negative pressures or other odd behavior – removing a gas just removes its contribution.)
- If there's only one gas ($n = 1$), then $P_{\text{total}} = P_1$ – Dalton's law reduces to the ideal gas law for a pure substance (consistent result).
- Each partial pressure must be $\leq P_{\text{total}}$ and non-negative. If you ever calculate a partial pressure greater than total, something's wrong (likely a units or fraction error).

- **Use vs. related tools:** Use Dalton's law whenever dealing with ideal gas mixtures to find a total pressure or a partial pressure. For example, to find oxygen's partial pressure in air at 1 atm total, use $P_{O_2} = x_{O_2}\, P \approx 0.21(1\text{ atm}) = 0.21$ atm for dry air). This beats doing separate ideal gas calculations for each gas and is the correct approach under ideal conditions. (For non-ideal gases at very high pressure, Dalton's law doesn't strictly hold but those scenarios are beyond the FE exam scope.)

Common exam traps:

- **Mixing units:** Make sure all pressures are in the same units before summing. *You can't add* 200 kPa + 14.7 psi directly; convert one unit set first. Similarly, don't add gauge pressures to other gauge or absolute values blindly – convert everything to absolute.
- **Using wrong fractions:** Partial pressure ratio equals *mole* fraction (or volume fraction for ideal gases), *not* mass fraction. For instance, if a tank's gas is 10% by mass hydrogen, that is not 10% of partial pressure (since hydrogen's light). Use mole fraction for $P_i = x_i P$.
- **Forgetting shared T:** All gases in the mixture are at the same temperature (and volume). If a problem gives you moles of each gas and a temperature, you can find each P_i

via $P_i V = N_i RT$; all those P_i will naturally sum to P_{total} by algebra. Don't erroneously plug total N into one gas's $P = NRT/V$ without summing partials or computing x_i.

Exam Handbook Search Cues (Not affiliated with or endorsed by NCEES): "partial pressure", "ideal gas mixture", "mole fraction" (The exam handbook lists these formulas under Ideal Gas Mixtures; searching these terms will locate the relevant equations.)

Footnotes: Remember that "partial pressure" implies an **absolute** pressure of that component gas. If you see a phrase like "partial vacuum" or gauge, convert to absolute before applying Dalton's law. Also note that Dalton's law works for gases **only** – you wouldn't sum partial pressures of liquids in a mixture (there you'd use other relations like partial volumes or concentration). Finally, an analogous concept is **partial volume**: for ideal gases $V_i = x_i V_{\text{total}}$, though you're unlikely to need that on the FE exam except conceptually.

K11.T08.S02 – Mixture Gas Constant and Specific Heats of Mixtures

- **Principle introduction:** An ideal gas mixture's properties (like gas constant R or specific heats c_p, c_v) can be determined from its components' properties and composition. Essentially, you're finding a weighted average. The weighting can be by mole or mass, depending on the property. This is crucial for solving energy and thermodynamic problems where a mixture (say, air-fuel mix or products) has an effective c_p or when you need the mixture's gas constant to apply $PV = mR_{\text{mix}}T$. The key is to use **mass fractions for properties per unit mass**, and **mole fractions for properties per mole**. Keep the distinction clear to avoid mixing up your fractions!

Equation Passport: Ideal Gas Mixture Properties – computes the average molecular weight, specific gas constant, and specific heats for an ideal gas mixture from component data.

Formulas:

- *Average molecular weight:*

  $$M_{\text{mix}} = \sum_{i=1}^{n} x_i \, M_i,$$

  where x_i is the mole fraction of component i and M_i its molecular weight (mass per mole). M_{mix} gives the effective molar mass of the mixture.

- *Mixture gas constant:*

  $$R_{\text{mix}} = \frac{R}{M_{\text{mix}}},$$

  where R is the universal gas constant (8.314 J/(mol·K) in SI units). This yields R_{mix} in units of energy per mass·temperature (e.g. J/(kg·K)). *(Equivalently, you can compute R_{mix} by summing each component's specific gas constant weighted by mass fraction: $R_{\text{mix}} = \sum_i y_i R_i$, since $R_i = R/M_i$.)*

- *Mixture specific heats:*

  $$c_{p,\text{mix}} = \sum_{i=1}^{n} y_i \, c_{p,i}, \qquad c_{v,\text{mix}} = \sum_{i=1}^{n} y_i \, c_{v,i},$$

  where $c_{p,i}$ and $c_{v,i}$ are the specific heats (per mass) of component i. Here y_i is the mass fraction of component i in the mixture. (Using mass fractions ensures the result $c_{p,\text{mix}}$ has units J/(kg·K), same as each $c_{p,i}$.)

Variables (and units):

- x_i – mole fraction of component i (dimensionless).
- M_i – molecular weight of component i (kg/mol in SI; often expressed as kg per kmol for convenience). For example, $M_{O_2} \approx 0.032$ kg/mol (32 g/mol).
- M_{mix} – average molecular weight of mixture (kg/mol).
- R – universal gas constant = 8.314 J/(mol·K) (SI). *(In USCS, $R = 1545$ ft·lb/(lbmol·°R).)*
- R_{mix} – specific gas constant of mixture (J/(kg·K) in SI, or e.g. ft·lb/(lbm·°R) in USCS). This is the R value you'd use in $PV = mR_{\text{mix}}T$ for the mixture as a whole.
- y_i – mass fraction of component i (dimensionless).
- $c_{p,i}$ – specific heat at constant pressure for component i (J/(kg·K)). *Similarly $c_{v,i}$ for constant volume.*
- $c_{p,\text{mix}}$, $c_{v,\text{mix}}$ – mixture's effective specific heats (J/(kg·K)).

Assumptions & scope:

- All components are ideal gases and **no chemical reactions** occur. These formulas assume a stable mixture composition.
- The specific heats $c_{p,i}$, $c_{v,i}$ are taken at the mixture's temperature (or assumed roughly constant over the temperature range of interest). In many FE problems, you'll assume room-temperature heat capacities or values given in a table.
- The mixture is expressed either in terms of mole fractions or mass fractions. Be careful to use the correct formula for each basis (mole vs mass). Average molecular weight uses mole fractions; weighted c_p uses mass fractions for per-mass specific heats.
- These relations are typically applied at **constant composition**. If a process (like combustion) changes composition, you'd apply them before or after the reaction, not during. (But combustion introduces reacting mixtures, outside this subtopic's scope.)

Limit checks:

- If the mixture has only one component, these formulas revert to that substance's properties. For example, if 100% of the gas is nitrogen, then $M_{\text{mix}} = M_{\text{N2}}$, $R\}\} = R/M_{\text{N2}=R2}$, *and* c. This consistency check passes, as it should. $\}\} = c_{p,\text{N}_2}$
- If a light gas (low M_i) dominates the mixture, M_{mix} will be closer to that light gas's molecular weight, and R_{mix} will be relatively large (since $R_{\text{mix}} = R/M_{\text{mix}}$). Conversely, a heavy gas yields a larger M_{mix} and a smaller R_{mix}. *Sanity tip:* heavier gas = smaller specific R.
- For specific heats, if one component with a very large $c_{p,i}$ is present in even moderate mass fraction, it will noticeably raise $c_{p,\text{mix}}$. If your computed $c_{p,\text{mix}}$ ends up outside the range of the individual $c_{p,i}$ values, double-check the math (you might have used mole fractions by mistake, for instance).

Use vs. related forms: Use these mixture property formulas whenever you need to treat a gas mixture *like a single effective gas* in calculations (e.g., in $PV = mRT$ or in energy/entropy formulas). For instance, in an internal energy change $\Delta U = m\, c_{v,\text{mix}} \Delta T$, you'd use $c_{v,\text{mix}}$ for the mixture. If you're given a mixture in terms of **volumetric composition (vol% or mole%)**, find M_{mix} via mole fractions first. If you're given **mass analysis (mass% of each gas)**, you can directly plug those as y_i for c_p calculations, but to get R_{mix} you might convert to mole basis. In any case, stick to one basis consistently for each task. *(Alternate path:* For R_{mix}, there's a direct mass-fraction formula: $R_{\text{mix}} = \sum_i y_i R_i$, which gives the same result as R/M_{mix}.)*

Common exam traps:

- **Mole vs. mass confusion:** The most frequent mistake is using the wrong fraction type. Remember: use mole fractions for molecular weight averaging; use mass fractions for averaging specific heats (since those are per unit mass). For example, if a mixture is 50% O_2 and 50% He by *moles*, those gases are ~89% and 11% by *mass* respectively (O_2 is heavier). Plugging 0.5 as a mass fraction for O_2 would be incorrect for $c_{p,\text{mix}}$ – you'd need the actual mass fraction. Always convert if necessary before applying formulas.
- **Inconsistent R units:** $R_{\text{mix}} = R/M_{\text{mix}}$ requires R and M_{mix} in consistent units. In SI, use $R = 8.314$ J/(mol·K) and M in kg/mol to get R_{mix} in J/(kg·K). If you accidentally use M in grams per mole, your R_{mix} will be off by 1000. Likewise, in USCS, if M is in lbm/lbmol, use $R = 1545$ ft·lb/(lbmol·°R) to get R_{mix} in ft·lb/(lbm·°R).
- **Assuming linear blend of k (ratio of specific heats):** The ratio $k = c_p/c_v$ for a mixture is *not* directly a simple average. You should compute $c_{p,\text{mix}}$ and $c_{v,\text{mix}}$ separately and then take the ratio. A common trap is to average the individual k_i values – that won't yield the correct k_{mix} generally. Instead, use $k_{\text{mix}} = c_{p,\text{mix}}/c_{v,\text{mix}}$.
- **Vol% vs mole% vs mass%:** Remember that "% by volume" for gases = % by mole (ideal gas). The exam might give composition in volume percent (especially for air or exhaust gases). Treat those numbers as x_i. Only if they explicitly give mass percentages would you treat them as y_i. Converting between them may be required if, say, you need $c_{p,\text{mix}}$ from a volume% composition – convert to mass fractions first.

Exam Handbook Search Cues (Not affiliated with or endorsed by NCEES): "mole fraction", "mass fraction", "molecular weight", "mixture cp" (The handbook's *Thermodynamics* section under Ideal Gas Mixtures lists these relations and the definitions of x_i, y_i, M, etc. Searching any of those terms will get you to the right formulas.)

Footnotes: The universal gas constant R appears in different forms: in SI units, $R = 8.314$ J/(mol·K), and for one kmol it's 8.314 kJ/(kmol·K); in USCS, $R \approx 1545$ ft·lb/(lbmol·°R). The value of 0.622 that you'll see in the next subtopic for humid air is actually the ratio of two R values – it's $\frac{R_{\text{water vapor}}}{R_{\text{dry air}}} = \frac{R/M_v}{R/M_a} = \frac{M_a}{M_v}$ (approximately 28.97/18.02). Also note, standard dry air has $M_{\text{air}} \approx 28.97$ kg/mol, giving $R_{\text{air}} = \frac{8.314}{0.02897} \approx 287$ J/(kg·K). It's useful to recognize that number: 287 J/(kg·K) for dry air. Similarly, ideal diatomic gases at room temperature have $c_p \approx 1005$ J/(kg·K) (for air), and monatomic gases like helium have much lower c_p per mass due to their high R (light molecule). These are just reference points – the exam will either give you needed values or expect you to retrieve them from the handbook.

K11.T08.S03 – Air–Water Vapor Mixtures (Psychrometrics Intro)

- **Principle introduction:** Moist air (a mixture of dry air and water vapor) is a prime example of an ideal gas mixture with practical importance (think HVAC and atmospheric conditions). Psychrometrics is the study of moist air properties. Key concepts include:
- **Partial pressures in moist air:** Dry air and water vapor each exert partial pressures such that $P_{\text{total}} = P_a + P_v$. Here P_a is partial pressure of dry air, P_v is partial pressure of water vapor. Dry air behaves as one ideal gas, water vapor as another; together they follow Dalton's law under typical conditions.
- **Humidity measures:** We quantify how much water vapor is in the air using **specific humidity (humidity ratio)** ω and **relative humidity** φ. ω relates the mass of water to mass of dry air, while φ compares the actual water vapor pressure to the maximum possible (saturation pressure at that temperature).
- **Thermodynamic properties:** Moist air has an enthalpy that includes contributions from both dry air and vapor. Processes like cooling, dehumidification, or heating moist air often involve changes in ω and require using these mixture concepts.

Definition/Equation Passport: Humidity Ratio & Related Psychrometric Quantities – characterizes the moisture content of air and key related terms for ideal air–vapor mixtures.

Specific Humidity (Humidity Ratio) ω: The humidity ratio ω is defined as the mass of water vapor per mass of dry air in the mixture. In formula form,

$$\omega = \frac{m_v}{m_a},$$

where m_v is the mass of water vapor and m_a is the mass of dry air. Because both components behave ideally, ω can be expressed using their partial pressures:

$$\omega = 0.622\,\frac{P_v}{P_a} = 0.622\,\frac{P_v}{P_{\text{total}} - P_v}.$$

The constant 0.622 is the ratio $\frac{M_v}{M_a}$ (molar mass of water vapor ≈18.0 kg/kmol, dry air ≈28.97 kg/kmol). This makes ω a dimensionless ratio, often expressed as e.g. "kg of water per kg of dry air". **Use:** ω lets you quantify absolute moisture content; it's used to find properties like moist air enthalpy and in mass balance calculations (e.g. how much moisture is added or removed).

Relative Humidity φ: Relative humidity (RH, ϕ) is defined as the ratio of the actual water-vapor partial pressure to the saturation pressure at the same dry-bulb temperature:

$$\phi = \frac{P_v}{P_{\text{sat}}(T)}$$

Here $P_{\text{sat}}(T)$ (sometimes noted P_g in the handbook) is the vapor pressure of water when air is saturated at temperature T. φ is expressed as a fraction or percentage.

Use: φ tells you how "full" of moisture the air is (100% means saturated air, on the verge of condensation). It's directly measured by humidity sensors and often given in problems. You might use φ to find P_v (since $P_v = \phi \cdot P_{\text{sat}}$) and then find ω, or vice versa.

- **Dew-Point Temperature T_{dp}:** The dew point is the temperature at which the air would become saturated (**100% RH**) if cooled at constant pressure. In other words, it's the temperature at which $P_{\text{sat}}(T_{dp}) = P_v$ for the current P_v. **Use:** If you know P_v in the air, you can find T_{dp} by seeing at what temperature the saturation pressure equals that P_v. Dew point is important for predicting condensation; on the exam you might be given two of the three (dry-bulb T, RH, dew point) and asked to find the third, often by using tables or given saturation pressures.

  Enthalpy of moist air h: Enthalpy for a moist air mixture (per kg dry air) is given by

  $$h = h_a + \omega\, h_v,$$

  where h_a is the enthalpy of dry air portion and h_v is the enthalpy of the water vapor (both per kg). In practice, a reference state is used (0 °C, 0 kJ/kg reference often) – but on the FE exam, you'd typically use the formula differences or values from charts. This relationship shows adding moisture (at a given temperature) adds enthalpy because h_v (water vapor's heat content) is significant (includes latent heat). **Use:** You might use this in cooling/heating problems to find how much energy is removed or added when dehumidifying or humidifying air.

- **Wet-Bulb Temperature T_{wb}:** The wet-bulb temperature is the equilibrium temperature an air parcel cools to by evaporating water into it adiabatically. Practically, it's measured with a thermometer wrapped in a wet wick – the lowest temperature it reads is T_{wb}. It reflects the combined cooling effect of evaporation and gives an indication of the air's moisture content. **Use:** While you likely won't calculate T_{wb} from first principles on the exam, you should know that on a psychrometric chart the state of moist air can also be determined by T_{wb} (lines of constant wet-bulb). It usually lies between dry-bulb and dew point temperatures for a given state.

- **Humid Volume:** Defined as the total volume of moist air per mass of dry air (m³/kg dry air). It's essentially specific volume of the mixture on a per-dry-air basis. It increases with temperature and moisture. This is a more niche property; if needed, the psychrometric chart or formula $v_{\text{moist}} = \frac{R_{\text{air}}T}{P_a}$ (plus vapor component) could be used, but it's rarely needed in calculation form on the FE.

Assumptions & scope:

- The total pressure P_{total} of the air-vapor mixture is typically near 1 atm in HVAC problems, and the mixture is treated as an ideal gas mixture. Deviations at very high pressure or extremely humid, hot conditions are not considered on the FE exam – assume ideal behavior unless told otherwise.
- The formula $\omega = 0.622\,\frac{P_v}{P_{\text{total}} - P_v}$ assumes **standard air composition** for dry air to get that 0.622 constant. That constant is valid for Earth's atmosphere composition ($M_{air} \approx 28.97$). You don't need to re-derive it; just remember 0.622 is a fixed factor in the humidity ratio formula on Earth.
- Psychrometric relationships assume any condensed phase (liquid water) is handled separately. For instance, if air is saturated and more water is added or temperature drops, excess water condenses out – the formulas still apply to the remaining vapor in equilibrium. (Such processes might require iterative or chart solutions beyond a straightforward formula plug-in.)

Limit checks:

- If there is **no water** in the air ($P_v = 0$), then $\omega = 0$ and $\phi = 0$. The formulas give $\omega = 0$ clearly, and $\phi = 0/P_{sat} = 0$. This makes sense: zero moisture means zero humidity.
- If air is **saturated** (holding as much water as possible at that T), then $P_v = P_{sat}(T)$ and by definition $\phi = 1.0$ (100%). The humidity ratio at saturation would be $\omega_{\text{sat}} = 0.622\,\frac{P_{sat}}{P_a}$. As T increases, P_{sat} increases, so saturated warm air carries a higher absolute humidity (ω) than saturated cold air – a reality the formulas reflect. If you push ϕ above 1 in a calc, you've gone unphysical; it means you assumed more vapor than saturation allows (extra would condense).
- Typical values: At 25 °C and 1 atm, $P_{sat} \approx 3.17$ kPa. So if $\phi = 50\%$, $P_v \approx 1.585$ kPa. Plugging in: $\omega \approx 0.622 * 1.585/(101.3 - 1.585) \approx 0.0098$ (about 0.98%). That's roughly 10 grams of water per kg of dry air – a reasonable humid day value. If you got, say, ω = 0.5 (50% by mass!), that would be ridiculously high – a sign of error. So expect ω in the range of 0 to maybe 0.03 (3%) for most atmospheric conditions; even tropical rainforest air might be around 0.03–0.04.
- Dew point can never exceed the dry-bulb temperature. If you compute a dew point higher than the given air temperature, something's wrong (likely mis-used φ or looked up wrong saturation value). Dew point equal to dry-bulb means saturation (φ=100%).

Use vs. related tools: Use the humidity ratio formula to convert between partial pressures and a convenient mass ratio when dealing with mixing or energy calculations. For example, if a problem gives dry air flow and moisture content, ω helps determine how much water mass is involved. Use φ (relative humidity) as a directly given or measured quantity to find P_v or to figure out how close air is to saturation (for comfort or condensation questions). These psychrometric quantities often go hand-in-hand: typically, you might use two of T, φ, ω, T_{dp} to find the others. The **psychrometric chart** (provided in the handbook for reference) graphically connects these properties: given two independent properties (say dry-bulb T and φ), you can find ω, T_{dp}, h, etc. on the chart. While you won't reproduce the chart in the exam, knowing what the relationships are helps you decide which formula to apply. For instance, given T and φ, you'd: (1) get $P_{sat}(T)$ from the handbook table/chart, (2) compute $P_v = \phi \cdot P_{sat}$, then (3) plug into ω formula if needed. Or to get dew point, solve $P_{sat}(T_{dp}) = P_v$ (likely by looking up where saturation pressure equals that P_v).

Common exam traps:

- **Unit mix-ups for pressure:** Ensure consistency of units when using 0.622 formula. If P_v is in kPa, use P_{total} in kPa as well. The 0.622 constant is unitless, but it assumes you're taking the ratio of pressures in the same units. Don't, for example, use P_v in mmHg and P_{total} in atm in the same fraction.
- **Forgetting to subtract P_v from total:** A common mistake is to compute ω as $0.622\frac{P_v}{P_{\text{total}}}$ (forgetting the $(P_{\text{total}} - P_v)$ in the denominator). Remember, $P_a = P_{\text{total}} - P_v$. Using P_{total} in place of P_a will overestimate ω. The difference is small at low humidities (when $P_v \ll P_{\text{total}}$), but it can skew answers at high humidity. Use the full formula given.
- **Mixing up φ and ω:** These two humidity measures are related but not the same. φ is relative (percentage of saturation), ω is absolute (mass ratio). The exam might give one and ask for the other. If you plug a relative humidity (say 50%) directly into the ω formula or treat φ as if it's ω, you'll get nonsense. Always go through partial pressures: φ gives P_v via $P_v = \phi P_{sat}$, then get ω from P_v.
- **Using the wrong saturation data:** To find $P_{sat}(T)$ (for water), use the water vapor saturation pressure table or equation provided (likely in the exam handbook's thermodynamics/chemistry section). Don't confuse saturation pressure with a partial pressure from something else. Also ensure you pick the entry for the correct temperature (e.g., saturation pressure at the *dry-bulb* or at the dew point, depending on what you're solving for). A minor mis-reading of the table can lead to big errors, so double-check units (some tables might use bar, others kPa, etc. – the FE handbook typically uses kPa for vapor pressure of water).
- **Wet-bulb vs. dew point:** It's easy to confuse these if you're not careful. Remember: dew point is when condensation starts (a temperature on the cold side), wet-bulb is an equilibrium cooling temperature when water evaporates (usually a bit higher than dew point but lower than dry-bulb). If a question references a thermometer with a wet cloth, it's hinting at wet-bulb. If it talks about water starting to condense on a surface, that's dew point.

Exam Handbook Search Cues (Not affiliated with or endorsed by NCEES): "psychrometrics", "humidity ratio (ω)", "relative humidity", "dew point", "wet bulb" (These terms are used in the exam handbook's section on Psychrometrics. For example, searching "humidity ratio" or the symbol ω will bring you to the definitions and formula for ω = 0.622… etc., and "relative humidity" or "wet-bulb" will find those definitions. The psychrometric chart is also provided in the handbook for reference, but numerical problems can be solved with the formulas above in most cases.)

Footnotes: In some texts or older references, specific humidity (ω) might be denoted by other symbols like W or even H – but the FE exam (and our usage) sticks to ω. The value 0.622 is basically $\frac{M_a}{M_v}$ as noted; if more precise molecular weights are used (28.9647 and 18.0153), the number is 0.6219, but 0.622 is accurate enough. Also note that when dealing with moist air, **all pressures** (partial and total) must be in absolute terms (e.g., use 101.3 kPa for 1 atm). Psychrometric data like saturation pressure for water are given as absolute pressures. A quick sanity check: P_v can never exceed P_{total}; at ordinary temperatures it's usually only a few kPa at most. Finally, while not officially part of this subtopic, remember that if you needed the *mole fraction* of water vapor in the air, you could get it from partial pressure as $y_v = P_v/P_{\text{total}}$ (don't confuse that with the mass ratio ω – they are different!). Keep these concepts straight, and you'll navigate any FE question on moist air with confidence.

Topic 09 - Psychrometrics

Topic Overview: Psychrometrics deals with the thermodynamic properties of air–water vapor mixtures. In simple terms, it's about **moist air** – the air we breathe – and measures like humidity and temperature that describe its state. This topic is crucial for **FE Mechanical Exam** problems involving air conditioning, drying processes, or any scenario where moisture in air affects energy calculations. You'll typically face questions asking for things like humidity ratios, relative humidity, dew point, or the use of a **psychrometric chart** to find unknown properties. Mastering psychrometrics means you can confidently handle questions about air conditioning and evaporative cooling on exam day, rather than feeling "under water" with the concepts.

K11.T09.S01 – Air–Water Vapor Mixture at 1 atm (Psychrometric Basics)

Principle Introduction: Psychrometrics begins with viewing atmospheric air as a mixture of **dry air** and **water vapor** at roughly constant pressure (about 1 atm). This approximation lets us apply ideal gas mixture rules because at near atmospheric conditions, both components behave like ideal gases. Key points include:

- **Atmospheric Air ≈ Dry Air + Water Vapor:** "Dry air" refers to all the gases in air except water vapor (mostly nitrogen and oxygen), and **moist air** means dry air carrying some water vapor. We assume a fixed total pressure (≈ 1 atm) for the mixture, which is reasonable for most engineering problems near sea level.
- **Ideal Gas Mixture Assumption:** At 1 atm and typical temperatures, both dry air and water vapor behave nearly ideally. This means each component follows $PV = mRT$ with its own partial pressure. The overall pressure P is the sum of the dry-air partial pressure P_a and the water-vapor partial pressure P_v, so $P = P_a + P_v$. Unless another value is given, we typically use $P \approx 101.3$ kPa (standard atmospheric pressure). [^1]
- **Independent Component Behavior:** Because of the ideal gas model, we can treat the dry air part and the water vapor part separately when calculating properties. For example, the amount of water vapor (humidity) is often expressed relative to the dry air mass or pressure without interfering with the dry air's behavior. This separation underpins all psychrometric definitions and formulas.

Definition/Note Passport: *Psychrometric Mixture – dry air & water vapor at 1 atm*

- **Plain-language definition:** Psychrometric mixture (moist air) is simply atmospheric air treated as a combination of dry air and water vapor. Dry air is the part with no moisture; water vapor is the gaseous moisture. At typical conditions (around 1 atm, moderate temperature), this mix obeys ideal gas laws for each constituent.

- **Where it matters (exam impact):** Many FE problems assume air is at 1 atm and use psychrometric relationships that rely on this ideal mixture model. Recognizing that $P \approx 1$ atm and constant means you can directly use standard charts and formulas (which are derived for 1 atm).

- **Pitfall or confusion point:** Remember that **water vapor pressure is not the same as total air pressure**. P_v is usually much smaller than P (for example, at 25 °C and 50% humidity, P_v is only a few kPa). Don't mistake a saturated vapor pressure for the entire pressure of the system. Also, "absolute humidity" in some contexts can mean a different measure (mass of vapor per volume of air), but on the exam it's synonymous with humidity ratio by mass ^2.

- **Micro-check:** *True/False:* In an ideal air–vapor mixture at 1 atm, the dry air and the water vapor each exert 1 atm of pressure. **False.** (They **share** the 1 atm; e.g., if water vapor is 2 kPa, dry air is about 99 kPa.)

Exam Handbook Search Cues (Not affiliated with or endorsed by NCEES): *psychrometrics, dry air, water vapor, mixture, ideal gas, 1 atm*

Footnotes:

1. *Unit nuance:* Always use **absolute pressure** (e.g., kPa or atm) for calculations. If given gauge pressure or if at high altitude, adjust to actual absolute pressure – but most psychrometric charts and formulas assume sea-level 1 atm conditions.

2. *Terminology note:* Moist-air terminology is not perfectly standardized across textbooks. In this guide, **ω always means (mass of water vapor)/(mass of dry air)**. If you ever see a term like "absolute humidity" in another source, double-check the units as some authors use it for a **mass-per-volume** quantity rather than a mass ratio.

Variations, Related Forms, Typical Values: At 1 atm, moist air typically contains a small fraction of water by mass. For example, hot desert air (low humidity) might have a humidity ratio under 0.005 (i.e., < 5 g of water per kg dry air), while tropical humid air might reach around 0.03 (30 g/kg). If **100% humidity** (saturated air at 1 atm), the maximum P_v equals the saturation pressure of water at that temperature (e.g. about 3.2 kPa at 25 °C), which still is only a few percent of 1 atm. These values imply that most of the air's pressure is from dry air, justifying why we treat dry air's portion as ~1 atm in calculations.

Explanation & Analysis: The foundation of psychrometrics is recognizing air as a binary gas mixture. On the FE exam, you won't need to derive gas mixture laws, but you should understand that **each gas in the mixture exerts its own partial pressure**. The dry air carries the bulk of the pressure, and the water vapor's partial pressure depends on how much moisture is in the air. Because of the ideal gas assumption, properties like temperature are **shared** between dry air and vapor (they're in thermal equilibrium), while partial pressures and masses are distinct.

What does this mean for problem-solving? It means any time you have moist air, you can find the water vapor content by using partial pressures or mass ratios without messing up the dry air calculations. For instance, if you know the air is at 30 °C with 50% relative humidity, you can look up the saturation pressure of water at 30 °C (about 4.2 kPa), take half of that (2.1 kPa) as the actual P_v, and deduce the dry air pressure is roughly $101.3 - 2.1 \approx 99.2$ kPa. This separation of pressures is key: it lets us define all the psychrometric terms (coming up next) in a clean way. Essentially, **the ideal mixture model is the canvas on which the**

psychrometric chart is drawn – with one axis usually for dry air's temperature and one for the moisture content.

K11.T09.S02 – Humidity, Moisture Content, and Psychrometric Properties

Principle Introduction: This subtopic covers the core properties that quantify moisture in air and related temperatures. These include **humidity ratio**, **relative humidity**, and the trio of temperatures that describe moist air's condition: **dry-bulb, wet-bulb, and dew-point**. Each term has a specific meaning and formula or definition:

- **Dry-Bulb Temperature (DBT, T_{db}):** The "plain" air-mixture temperature; i.e., the temperature of the moist air itself, not influenced by evaporation at the sensor. This is the temperature you typically use for property lookups (like saturation pressure) and for most air-side calculations.
- **Wet-Bulb Temperature (WBT, T_{wb}):** A temperature that reflects evaporative-cooling potential. If a surface is wetted and exposed to airflow, evaporation removes energy and the reading settles at a lower temperature than the dry-bulb (unless the air is already saturated). For unsaturated air, $T_{wb} < T_{db}$; at saturation, $T_{wb} = T_{db}$.
- **Dew-Point Temperature (DPT, T_{dp}):** The condensation threshold for the air's current moisture level. If the air is cooled (at roughly constant pressure) without changing how much vapor it contains, the first onset of condensation occurs when T reaches T_{dp}.
- **Humidity Ratio (ω):** The mass-basis moisture loading of the air: $\omega \equiv$ (mass of water vapor)/(mass of dry air). Keep ω conceptually separate from relative humidity φ: ω is a mass ratio, while φ is a saturation percentage.
- **Relative Humidity (RH φ):** This is the **fraction of moisture content relative to saturation** at the same temperature, expressed as a percentage or decimal. Formally, $\phi = \frac{P_v}{P_{sat}(T)}$, the ratio of actual vapor partial pressure (P_v) to the saturation vapor pressure at the dry-bulb temperature ($P_{sat}(T)$). RH tells how "full" of moisture the air is: 100% means the air holds all the vapor it can at that temperature (saturated), 50% means half as much vapor as it could hold, etc. **Crucially, RH depends on temperature** – if air is heated or cooled without adding/removing moisture, ϕ will change even though ω stays the same.

Key Formulas & Definitions: Several relationships tie these properties together for moist air at total pressure P (usually 1 atm):

- **Humidity Ratio Formula:** The humidity ratio ω relates the masses or partial pressures of vapor and dry air:

$$\omega = \frac{m_v}{m_a} = 0.622\,\frac{P_v}{P_a} = 0.622\,\frac{P_v}{P - P_v},$$

where m_v and m_a are the masses of water vapor and dry air, respectively, P_v is the water-vapor partial pressure, and P_a is the dry-air partial pressure. The constant 0.622 comes from the ratio of the gas constant of water vapor to dry air (it's actually $R_{dryair}/R_{vapor} \approx 0.622$), and it effectively corrects for the difference in molecular weights (water vapor is lighter than air).

Variables and units: m_v and m_a in kg; P_v, P_a, P in consistent pressure units (e.g. kPa). ω is dimensionless (kg/kg), often reported as e.g. 0.010 kg/kg or as 10 g vapor per kg dry air.
Assumptions: Valid for ideal gas mixtures at steady state. P must be total absolute pressure of the air, and $P_v \ll P$ typically (so that dry air still approximates P). The formula $\omega = 0.622\frac{P_v}{P-P_v}$ assumes the mixture is at 1 atm or known P; it's derived from $P_v = \omega P_a/0.622$ plus $P = P_a + P_v$.
Limit tests: If no moisture ($P_v \to 0$), then $\omega \to 0$ (dry air contains zero water – makes sense). If P_v increases toward P (air becoming all vapor), ω grows very large (in fact as $P_v \to P$, $P_a \to 0$ and $\omega \to \infty$ in theory). In reality, at 100% RH and high temperature, P_v can approach a fraction of P (but never exceed P), so ω usually stays below ~0.1 (100 g/kg) for terrestrial conditions.

Use vs. sibling measures: Use ω when you need the **absolute moisture content** (for example, in mass/energy balances or mixing problems). It's the conserved quantity when mixing air streams (unlike RH which can change with temperature). Use ω instead of φ when the problem asks for how much water (by mass) is in the air.
Common exam traps: Confusing ω with φ (mass ratio vs percentage). Also, forgetting the 0.622 factor – a common mistake is to erroneously use $\omega \approx P_v/(P - P_v)$ without 0.622; this would ignore molecular weight differences and give a slightly off result. Another trap is mixing units (e.g., using P_v in mmHg while P in kPa in the formula). Always ensure P_v and P use the same units and are absolute pressures.

- **Relative Humidity Formula:** The relative humidity φ is given by

$$\phi = \frac{P_v}{P_{sat}(T)} \times 100\%,$$

where $P_{sat}(T)$ is the saturation vapor pressure of water at the dry-bulb temperature T. (If you use φ as a decimal, omit the 100%.) This formula essentially compares actual vapor content to the maximum possible at that temperature. It has no units (often expressed as a percent). Key understanding: if you know φ and T, you can find $P_v = \phi \cdot P_{sat}(T)$ – meaning the actual vapor pressure is the fraction φ of the saturation pressure.

Typical values: φ can range from 0% (bone-dry air, no moisture) up to 100% (saturated air). Comfortable indoor air might be around 50%. Desert air might be 20% or less.
Pitfalls: φ is *temperature-dependent*. For instance, air at 20 °C and 50% RH, if heated to 30 °C, will have a lower RH even though the moisture ω hasn't changed (because $P_{sat}(30°C) > P_{sat}(20°C)$, so the same P_v becomes a smaller fraction). The exam may exploit this by asking what happens to RH when air is heated or cooled. Also, remember φ is a ratio of pressures (or equally, ratio of vapor *partial pressure* to *saturation pressure*). Sometimes people mistakenly take it as a ratio of vapor mass fractions or mix up dew point with RH – keep the definition clear: it's about pressure (or partial pressure), which ties directly to how evaporation/condensation equilibria work.

Exam Handbook Search Cues (Not affiliated with or endorsed by NCEES): *humidity ratio ω, relative humidity φ, wet-bulb, dew point, psychrometric properties* (These terms are all listed under **Psychrometrics** in the exam reference.)

Footnotes:

- *Symbol conventions:* In the exam reference, ω (omega) is used for humidity ratio, and φ (phi) for relative humidity. Dry-bulb T usually has no subscript (understood as ambient air temperature),

wet-bulb is T_{wb}, and dew-point is T_{dp}. Be prepared to spot these symbols quickly on the reference page.

- *Units:* Ensure temperatures for saturation properties are in the correct units (usually °C or K as required by tables). If using tables for P_{sat}, remember to convert pressure units if needed (e.g., the steam table might give P_{sat} in bar or kPa). Humidity ratio ω is technically dimensionless, but thinking of it as "kg per kg" helps clarity.

- *Approximation:* The formula $\omega = 0.622\frac{P_v}{P-P_v}$ assumes the mixture pressure is around 1 atm and uses the ratio of gas constants 0.622 (which is actually M_v/M_a for molecular weights). This is valid for air-water vapor; if a problem ever involved a different gas-vapor mix, that constant would differ (but such scenarios are unlikely on FE Mechanical).
- *Dry vs Wet vs Dew:* It's easy to get tongue-tied: Dry-bulb = actual air temp. Wet-bulb = lowest temp via evaporation. Dew-point = temp at which condensation starts. A quick consistency check: **Wet-bulb is in between** (lower than dry-bulb, higher than dew if unsaturated). If you find a computed dew-point higher than the given dry-bulb, or a wet-bulb higher than dry-bulb, you've made a mistake – that's physically impossible.

Variations, Related Forms, Typical Values: One useful related measure is **percentage humidity** by mass, sometimes called *humidity ratio in percent*. For example, if $\omega = 0.010$, that's 1.0% moisture by mass (or 10 g/kg). Psychrometric charts often have a scale in g/kg for convenience. Also note the concept of **saturation margin**: $100\% - \phi$ tells how far from saturation the air is (e.g., 40% RH means the air is 60 percentage points away from saturation). Typical comfortable indoor conditions: ~$T = 22°C$, $\phi = 50\%$ (which yields $\omega \approx 0.009$ or 9 g/kg). A humid summer day might be $T = 30°C$, $\phi = 70\%$ ($\omega \approx 0.019$ or 19 g/kg). These values give a sense of the range of ω you might encounter.

Another term occasionally encountered is **specific volume of moist air** (inverse of density, in m³/kg dry air). It's not listed above, but on the psychrometric chart it's indicated by faint diagonal lines. Specific volume combines T and ω effects and can be derived from the ideal gas law applied to the dry air per kg (plus the volume contributed by the vapor). It's seldom directly asked on FE, but just know it exists as "humid volume" mentioned in references.

Special Note – Using the Psychrometric Formulas in Calculators: The Casio/TI/HP calculators allowed in the FE can handle these computations, but be careful with parentheses. For example, computing $\omega = 0.622\frac{P_v}{P-P_v}$, you might enter: 0.622 * Pv / (P - Pv). If you're using a found value for P_v (say from φ * P_{sat}), it's wise to compute that first then plug into the ω formula to avoid one big messy string that's prone to error. Also, ensure you're not rounding off intermediate saturation pressures too much; a tiny difference in P_v can slightly affect φ or ω (though on the exam, answers will have tolerance).

Explanation & Analysis: Let's break down each property further to solidify understanding:

- **Dry-Bulb Temperature:** This is straightforward – it's just the normal temperature. On exam day, when a problem states "the air is at 30°C," that's the dry-bulb. Why emphasize it? Because psychrometrics introduces other temperatures (wet-bulb, dew-point) which are different concepts. The dry-bulb is what you plug into most equations (like finding P_{sat} or using $PV = RT$ for air). No special calculation needed – just keep track of it.

- **Wet-Bulb Temperature:** Imagine you have a thermometer wrapped in a wet cloth (the classic **sling psychrometer** setup). As you wave it in the air, water evaporates and cools the thermometer. It will settle at some lower temperature – that's the wet-bulb. Physically, at wet-bulb conditions, the **rate of evaporative cooling equals the rate of heat gain from the air**, reaching a steady state. Why is this important? Because the wet-bulb tells you about the air's **adiabatic cooling potential**. If you know T and T_{wb}, you can gauge how much moisture would be added if you cooled the air to T_{wb} by evaporation (like in a cooling tower or evaporative cooler). In exam terms, T_{wb} is used with charts or formulas to find ω or φ. For instance, air at 30°C dry-bulb might have a wet-bulb of 20°C if it's fairly dry. That difference (10°C) is related to how low the enthalpy can drop by evaporation. You won't typically calculate T_{wb} from scratch via formula (that requires iterative or psychrometric equation calculations), but you might be given it or read it off a chart.

- **Dew-Point Temperature:** This one's conceptually simpler: cool the air until water starts condensing – that temperature is T_{dp}. It's directly tied to moisture content. If you know T_{dp}, you can immediately find the actual vapor pressure P_v because $P_v = P_{sat}(T_{dp})$. This is extremely handy: many exam problems might give you T_{dp} as a way to specify how much moisture is in the air **without explicitly giving φ or** ω. For example, "air at 35°C has a dew point of 15°C" – from this, you'd know P_v corresponds to saturation at 15°C (about 1.7 kPa), and from that you can find ω or φ relative to the 35°C condition. Another common use: determining if condensation will occur. If a surface (or the air after cooling) is at a temperature below the air's dew point, condensation will occur. For instance, if air at 25°C, 60% RH has a dew point ~17°C, then any cooling coil or surface at <17°C will start getting condensation (dehumidification). So dew point is the "warning" temperature for moisture issues.

- **Humidity Ratio ω vs. Relative Humidity φ:** These two are often confused by students, but they are quite different. ω is an absolute measure – how many kg of water per kg of air, period. φ is relative – how saturated is the air. Think of φ as how full your "moisture tank" is, whereas ω is the size of the tank that's filled. You can have a high ω (lots of water in the air) but also a high temperature such that ϕ is moderate. Conversely, in cold air, a modest ω can correspond to very high φ because cold air's capacity is low. For FE exam calculations, if you are asked for moisture content in an engineering sense (like for a mass balance or mixing ratio), they want ω. If they ask how "humid" or likely condensation, they are hinting at φ or dew point.

Mathematically, once you have any two of these properties (say dry-bulb T and either T_{dp}, T_{wb}, φ, or ω), you can find all the others using tables or charts. For example, given T and φ: find $P_{sat}(T)$ from steam tables (in the exam handbook), multiply by φ to get P_v, then plug into the ω formula to get humidity ratio. Or given T and ω: invert the ω formula to get $P_v = \frac{\omega P}{0.622+\omega}$, then divide by $P_{sat}(T)$ to get φ, etc. These interrelations are the bread and butter of psychrometric calculations – and they're often faster to solve graphically on a chart, which brings us to the next subtopic.

K11.T09.S03 – Psychrometric Chart: Reading Moist Air State Points

Principle Introduction: The **psychrometric chart** is a graphical tool that plots all the psychrometric properties of air–water vapor mixtures in one chart. It's essentially a state map for moist air at a given pressure (usually 1 atm). Knowing how to read this chart is a quick way to solve exam problems without crunching too many equations, because you can visually find relationships between properties. Key features of the chart:

- **Axes:** The horizontal axis is **Dry-Bulb Temperature** (°C or °F), and the vertical axis is **Humidity Ratio** ($\mathrm{kg_{vapor}/kg_{dry\,air}}$). Every point on the chart represents a unique combination (T, ω) for air at 1 atm.
- **Saturation Curve:** The leftmost boundary curve (often curving upward) is the **100% RH line** – also called the **saturation line**. Points on this curve are saturated air (dew point equals the dry-bulb). The curve starts at the left-bottom (0 °C, 0 humidity) and rises steeply as temperature increases (because warm air can hold more moisture). Any point under this curve is unsaturated (somewhere less than 100% RH).
- **Constant RH Lines:** A family of curved lines sweep below the saturation curve, representing constant **Relative Humidity** levels (e.g. 20%, 40%, 60%, etc.). These lines start at the saturation curve (at the left/top ends) and bend downward to the right. Lower RH lines lie further from the saturation curve. So, given a point on the chart, you can see its relative humidity by which curve it's near or interpolate between curves.
- **Wet-Bulb / Enthalpy Lines:** Lines of **constant Wet-Bulb Temperature** (or equivalently, approximately constant enthalpy) run diagonally across the chart. In many charts, they are drawn as straight or slightly curved diagonal lines sloping downward from left to right. They might be labeled with the wet-bulb temperature (or sometimes labeled as enthalpy in kJ/kg dry air). All points on one such line have essentially the same T_{wb}. These lines are useful for processes like evaporative cooling (moving along a constant enthalpy line).
- **Other data:** Often the chart also shows **specific volume** lines (almost vertical slight diagonals) and sometimes **temperature difference lines** between dry-bulb and dew point. However, the primary ones to focus on for the FE are the RH curves, the saturation line, and the wet-bulb (enthalpy) lines.

Diagram Passport: *Psychrometric Chart (1 atm)*

- **Diagram role:** The psychrometric chart allows quick determination of moist air properties and process changes. By plotting or locating the air state on the chart, you can **read off values** like humidity ratio, relative humidity, wet-bulb, dew point, and enthalpy without lengthy calculations. It's essentially a graphical calculator for psychrometric equations.

- **Axes and quantities:** Typically, **Dry-Bulb Temperature** is on the x-axis (increasing to the right) and **Humidity Ratio (ω)** on the y-axis (increasing upward). In SI units, T might range from 0 °C to 50 °C, and ω from 0 up to ~0.030–0.050 (kg/kg) depending on the chart's scope. The **saturation curve** bounds the top-left of the chart. Sometimes a secondary top axis shows **enthalpy** in kJ/kg (since enthalpy is largely a function of T and ω).

- **Key regions and curves:** - The **saturation line (100% RH)** is a curved boundary; to its left no physical states exist (you can't have more than saturated moisture at a given T). - **Constant RH lines** (e.g. 10%, 30%, 60%) curve roughly parallel to the saturation line – higher RH curves lie closer to the saturation line.

- **Constant Wet-Bulb/Enthalpy lines** run diagonally. For example, a 20 °C wet-bulb line will intersect the saturation curve at 20 °C (because at saturation, dry-bulb = wet-bulb), and extend down-right from there. These lines indicate adiabatic cooling paths. - **Constant Volume lines** (specific volume) are near-vertical slight diagonals, usually not heavily emphasized unless needed for certain calcs (like finding density).

- **How to read it (exam-style):** Given any two independent properties (say T and φ), you can pinpoint the state on the chart by first moving to the given dry-bulb on the x-axis, then moving up to the humidity ratio that corresponds to φ (which requires finding the curve for φ and interpolating). Conversely, if given T and T_{dp}, you'd find T_{dp} on the saturation curve to get P_v and thus locate the point by matching that P_v to a humidity ratio at the given T. For process changes: moving **horizontal** on the chart means changing temperature at constant humidity (e.g. sensible heating/cooling with no moisture added/removed). Moving **vertical** means humidifying or dehumidifying at constant dry-bulb (like a steam injection or dehumidifier at constant T). Moving along a diagonal wet-bulb line means adiabatic cooling (evaporative cooling, where enthalpy stays roughly constant). Many HVAC processes trace rectangles or triangles on this chart; for FE, you may need to conceptually understand these moves (e.g., cooling and dehumidification moves down-left: cooler and drier).

- **Common misreads:** Watch the units – there are separate charts for SI and English units, so ensure you read the correct axes. It's easy to misread humidity ratio if you don't note the scale (it might be in g/kg on some charts). Also, do not confuse the saturation curve for a constant temperature line – remember, along that curve temperature is increasing as you go right even though you're at 100% RH. Another pitfall is interpolating between curves: for example, if your state lies between the 50% and 60% RH lines, you have to estimate the RH – don't just take a linear midpoint if the curves are nonlinear (though a small range interpolation is usually fine). Lastly, some forget that the chart is pressure-specific: using a 1 atm chart for high-altitude air (lower pressure) introduces error (the exam will typically assume standard pressure unless they explicitly give a different pressure and perhaps a corresponding chart or data).

Exam Handbook Search Cues (Not affiliated with or endorsed by NCEES): *psychrometric chart, ASHRAE chart, RH lines, wet-bulb lines* (The exam reference **includes a psychrometric chart** – familiarize yourself with it beforehand, including how to zoom/navigate it on the computer screen.)

Footnotes:

- The exam's psychrometric chart is provided for **standard atmospheric pressure** (there were separate charts for SI and US units in the reference). If a problem involves a different pressure (rare in FE, but say high altitude), strictly the chart would be off – but typically, they won't go there.

- Sometimes exam problems give a simplified chart snippet or just state needed values (like "at 25 °C and 40% RH, humidity ratio is X"). So, while knowing the chart is great, also be ready to fall back to calculations if needed (using the formulas from subtopic 2).

- If you haven't used a psychrometric chart much, practice locating points: e.g., find the state for 30 °C, 50% RH and check roughly what ω, T_{wb}, and T_{dp} you get. This builds intuition – for instance, you'd see T_{dp} is around 18°C for that state and T_{wb} around 24°C, etc., reinforcing the relationships.

Explanation & Analysis: Why use the chart? Because it's **fast and intuitive** once you know it. Let's illustrate with a typical exam-like scenario: *"Air at 32 °C dry-bulb and 50% RH is cooled sensibly (no moisture removed) to 20 °C. What is the new relative humidity?"*

You could do this by formula: find initial $P_v = 0.5 * P_{sat}(32°C)$, which requires $P_{sat}(32°C)$ from a table (~4.76 kPa). So $P_v \approx$ 2.38 kPa (stays the same during sensible cooling). Then find $P_{sat}(20°C)$ (~2.34 kPa). Compute new $\phi = P_v/P_{sat}(20°C) \approx 2.38/2.34 = 1.017$, which is about 101.7% – impossible, meaning actually some condensation would occur before reaching 20°C. So the correct process would involve hitting 100% RH at slightly above 20°C, then condensation (dew) if cooled further.

Now see how the **chart** handles this: At 32°C, 50% RH, plot that point. Draw a horizontal line left (cooling at constant ω) until you hit the saturation curve (100% RH) – that happens around maybe 22°C or so. From that point onward, you'd move left *and* down (cooling plus dehumidifying along the saturation line) to reach 20°C on the saturation line, which gives the final state as 100% RH at 20°C with some water condensed out. The chart immediately shows that you can't get to 20°C without reaching saturation. In other words, the chart inherently enforces physical limits like RH ≤ 100%.

This example highlights that charts are great for **visualizing processes**. For exam questions, if they provide a chart, use it to avoid heavy calculation. If they don't, you can still imagine an "internal chart" to sanity-check your answers. For instance, if you computed an RH > 100% like above, you'd know something's wrong – the chart perspective reminds you that once you hit saturation, excess moisture must condense (latent heat release, etc.).

Finally, remember that the psychrometric chart is essentially a plot of all those equations from subtopic 2. Every curve or line on it is described by a formula. But you don't need to memorize all those forms – just know how to find information on the chart. It's one of those tools where **pattern recognition** beats algebra under time pressure. Many engineers (myself included) have a mental image of the chart and use it to double-check calculations. With practice, you'll quickly estimate, say, that cooling air to its dew point will jack up RH to 100%, or that a wet-bulb of 15°C at a dry-bulb of 30°C implies quite dry air. The chart makes these relationships clear at a glance.

K11.T09.S04 – Using Psychrometric Relationships (Evaporative Cooling & Saturation Calculations)

Principle Introduction: In this subtopic, we focus on applying psychrometric relationships to solve typical FE exam problems. Common tasks include using **saturation pressure data** (from steam tables) to find moisture properties, and understanding the relationship between dry-bulb, wet-bulb, and humidity in processes like **evaporative cooling**. Key applications are:

Using Saturation Pressure (Steam Tables): To find or use properties like relative humidity or dew point, you often need the saturation pressure of water at a given temperature. The exam provides steam tables or equations for $P_{sat}(T)$. For example, to compute RH you might be given T and either φ or T_{dp}. You'd get $P_{sat}(T)$ from the table, then find P_v. This step is crucial: no guesswork – use the data. *E.g.*, at 40°C, $P_{sat} \approx 7.38$ kPa. If actual P_v is 2 kPa, then φ = 2/7.38 = 27%. Likewise, if dew point is given as 25°C, find $P_{sat}(25°C) \approx 3.17$ kPa; that is actually P_v. Now plug that into other formulas (like find ω or see what RH would be at a different T). Essentially, **steam table lookup + formula** is a common move.

Dry-Bulb, Wet-Bulb, and Humidity (Evaporative Cooling): In an **adiabatic evaporative cooling** process (no external heat added or removed, just water evaporating), the air's **wet-bulb temperature remains roughly constant** (this is because the process follows a constant enthalpy line). A classic scenario: air at 1 atm passes over water (like a cooling tower or swamp cooler). The air cools from T_{db1} to T_{db2} while picking up moisture from ω_1 to ω_2. If the process is ideal, T_{wb} stays the same throughout (equal to the exit air T_{db2} when fully saturated). The relationship tying T_{db}, T_{wb}, and humidity is often called the **psychrometric equation**, which comes from an energy balance between sensible cooling of air and latent heat of evaporation. In formula form, one representation (in SI units) is:

$$\omega_2 = \omega_1 + \frac{1}{h_{fg}(T_{wb})}\, c_{pa}\,(T_{db1} - T_{wb}),$$

when cooling from state 1 down to saturation at the wet-bulb T_{wb}. Here $h_{fg}(T_{wb})$ is the latent heat of vaporization at T_{wb}, and c_{pa} is the specific heat of air. This formula basically says the increase in humidity ratio equals the water evaporated to provide cooling from T_{db1} to T_{wb}. While you likely won't need to memorize this exact form, understanding it helps: **the larger the dry-bulb drop (T_1-T_{wb})**, the more moisture is added (hence higher ω gain). - **Finding Unknowns (step-by-step):** Many psychrometric problems boil down to carefully applying known values to find unknowns. For instance: "Given dry-bulb and wet-bulb, find RH." You would: (1) Use T_{wb} to get $P_{sat}(T_{wb})$ from tables. (2) Recognize that for a saturated adiabatic process, the vapor partial pressure at the wet wick is roughly $P_{sat}(T_{wb})$ minus a tiny depression (sometimes an empirical psychrometric constant factor times pressure difference, but often negligible for rough calc). (3) Approximate $P_v \approx P_{sat}(T_{wb}) -$ (a small term). For many practical purposes, you take $P_v \approx P_{sat}(T_{wb})$ when using a sling psychrometer. (4) Then find RH by $\phi = P_v/P_{sat}(T_{db})$. A more exact relation used in some references is:

$$P_v = P_{sat}(T_{wb}) - A(T_{db} - T_{wb})P\,,$$

where A is the psychrometric constant (around 6.6×10^{-4} K⁻¹ for 1 atm pressure when using T in °C and P in kPa). But unless the exam expects a numerical answer requiring this precision, a simpler approach is usually sufficient.

Using the Relationships – Example: Suppose the problem states: *"Air at a 30°C dry-bulb temperature and 50% relative humidity is passed through an adiabatic evaporative cooler. Estimate the outlet air temperature and humidity if the process reaches 90% RH."* How to solve? At 30°C, 50% RH we find initial ω (from chart or calc). Using formula: $P_{sat}(30°C) \approx 4.25$ kPa, so $P_v = 0.54.25 = 2.125$ *kPa. Then* $\omega_1 = 0.622 * 2.125/(101.3 - 2.125) \approx 0.0132$ *kg/kg. Now, in an ideal evaporative process, enthalpy is conserved, which means the state moves along a constant h (constant* T_{wb}*) line until RH = 90%. You could approach iteratively: guess an outlet* T_2 *(which should be lower), find* $P_{sat}(T_2)$ *and set* $\phi_2 = 90\%$ *to get* P_{v2}*, then* ω_2 *and see if* $h(T_2, \omega_2) = h(T_1, \omega_1)$*. On the exam, though, the faster method: use the psychrometric chart** – draw a line from the initial state along constant enthalpy (parallel to

constant T_{wb} lines) until you hit 90% RH curve. Read off T_2 and ω_2. You might get, say, $T_2 \approx 22°C$ and $\omega_2 \approx 0.018$ (just rough numbers). In absence of the chart, you could use the simpler formula earlier: choose T_{wb} equal to the initial wet-bulb (~ say initial $T_{wb} \approx 22°C$ from chart for 30°C, 50% RH), then at final 90% RH, T_2 would indeed be near that T_{wb}.

The key takeaway: **dry-bulb, wet-bulb, and humidity are interrelated through energy and mass balances**. If two are fixed, the third is determined (assuming constant pressure). For evaporative cooling, T_{wb} acts like an anchor – the air cannot cool below its initial T_{wb} without external help. So if the question asks for a minimum achievable temperature by evaporative cooling, it's essentially asking "what is the wet-bulb temperature?" of the initial air. Conversely, if given T_{db} and T_{wb}, you can find ω or φ by acknowledging that at T_{wb}, the air would be saturated, and using that condition in calculations.

Exam Handbook Search Cues (Not affiliated with or endorsed by NCEES): *saturation pressure of water, steam table, wet-bulb relation, adiabatic saturation, evaporative cooling*

Footnotes:

- The FE Reference Handbook provides steam tables and the psychrometric chart, but **not** an explicit formula linking T_{db}, T_{wb}, and ω beyond the basic definitions. You are expected to combine data from tables with the definitions. For instance, to use wet-bulb data, you might recall that at T_{wb} the air at the thermometer is 100% RH, and use that as an intermediate to find ω.

- Remember that **dew-point provides a direct handle on moisture content** (via saturation pressure at T_{dp} equals P_v), whereas **wet-bulb provides a handle on enthalpy**. If a problem gives you a wet-bulb reading, it's usually about a cooling or humidification process; if it gives dew-point, it's usually about condensation or initial moisture content.

- If using an exam-approved calculator for iterative tasks, be cautious of time. Often an approximate or conceptual answer is expected rather than a laborious iterative solution. That said, the psychrometric processes are typically designed to be solved in one or two steps by using either charts or straightforward formula application.

Variations and Typical Situations: Another classic scenario is **mixing of air streams**. You might have two air flows with different states mixing together. The resulting mixture's humidity ratio ω_{mix} will be a **mass-weighted average** of the inputs (since total water mass is conserved) and the enthalpy too if no heat is lost. On a psychrometric chart, mixing at constant total moisture is a straight line connecting the two state points, with the mixture point lying on that line according to the mix ratio. If they ask something like mixing or "conditioning" air by adding steam, just apply conservation: add humidity (for steam injection at constant dry-bulb, you'd move straight up on the chart; for mixing equal masses of two states, midpoint on the line connecting them, etc.).

Also, pay attention to units: sometimes humidity ratio might be given in grains per pound (in US units, 7000 grains = 1 lb) – convert if needed. The exam will likely stick to SI or straightforward units, but just be aware in case a weird unit pops up.

Explanation & Analysis: Let's dissect a typical **evaporative cooling** question in concept: *"Air at 35°C, 30% RH enters a direct evaporative cooler. What is the lowest temperature it could theoretically reach, and what would be the RH at that condition?"*

This is basically asking for the *adiabatic saturation* end state, which occurs at the air's initial wet-bulb temperature (lowest T, fully saturated). So the lowest temperature is the initial T_{wb}. We'd find T_{wb} for 35°C, 30% RH. Using either the chart or iterative calc: at 35°C, $P_{sat} \approx 5.62$ kPa; $P_v = 0.35.62 = 1.69$ *kPa;* $\omega \approx 0.6221.69/(101.3 - 1.69) = 0.0106$. Now, one way is to guess a wet-bulb and adjust: try 20°C: $P_{sat}(20) = 2.34$ kPa, saturated $\omega_{sat@20} = 0.6222.34/(101.3 - 2.34) = 0.0147$. *That's higher than 0.0106 (meaning if we cooled to 20°C and saturated, we'd have more moisture than we currently have, which is impossible without adding water – so maybe we won't reach full saturation by 20°C). Try 25°C:* $P_{sat}(25) = 3.17$ *kPa,* $\omega_{sat@25} = 0.6223.17/(101.3 - 3.17) = 0.0201$. Way higher. Try 15°C: $P_{sat}(15) = 1.705$ kPa, $\omega_{sat@15} = 0.622 * 1.705/(101.3 - 1.705) = 0.0106$ – aha, that matches our initial ω! So at about 15°C, the air would saturate with exactly 0.0106 humidity ratio. That implies the wet-bulb (and dew-point in this case) is ~15°C. So the lowest theoretical dry-bulb is 15°C and at that point RH is 100%.

On the chart, you'd locate 35°C, 30% and draw a line of constant enthalpy down-left until it hits the saturation curve: indeed around 15°C. This method underscores the power of combining **steam table data with the humidity ratio equation** to solve such questions systematically.

For the FE exam, always start with what's given: If a problem gives you two temperatures (like dry-bulb and wet-bulb, or dry-bulb and dew-point), immediately think of using the **steam tables** to get vapor pressures. If it gives you a relative humidity, translate that to either a dew-point or a partial pressure for convenience. Then use ω formulas as needed. Psychrometric problems often seem wordy, but they break down into a few mechanical steps:

1. **Extract known values:** Identify which two independent properties you have (e.g., T and φ, or T and T_{dp}, etc.).

2. **Steam table lookup:** If needed, get P_{sat} for any temperature involved (dry-bulb for RH calcs, dew-point itself gives $P_{sat}(T_{dp})$ directly as P_v).

3. **Apply definition formulas:** Compute P_v, ω, φ, or whatever is required using the formulas from subtopic 2.

4. **Interpret process if applicable:** If it's a process (cooling, heating, humidifying), decide which property stays constant (ω constant if no moisture added/removed, h constant if adiabatic humidification, etc.) and use that to find the final state (possibly iterating or using the chart).

5. **Double-check limits:** Ensure RH never exceeds 100%, temperatures make sense (dew-point ≤ dry-bulb, etc.), and units are consistent.

By practicing these steps, you'll gain speed. And remember, **you're not alone in finding this tricky at first** – many engineers have had to stare at a psychrometric chart until it clicked. Once it does, it actually becomes an easy topic on the FE because the questions are very formulaic (no pun intended!). Keep an eye out for keywords like "saturated," "dew-point," "wet-bulb" to know which path to take in solving the problem.

Topic 10 - Heating, Ventilation, and Air-Conditioning (HVAC) Processes

Thermodynamics – FE Mechanical Knowledge Area

Topic Introduction: HVAC processes deal with the conditioning of air – *heating*, *cooling*, *humidifying*, or *dehumidifying* it – to meet desired environmental conditions. On the FE Mechanical Exam, you'll encounter problems where you must analyze moist air using a **psychrometric chart**, compute **heating/cooling loads**, or understand the basics of **refrigeration cycles**. These questions are practical in nature: you might be asked to find the heat required to heat a ventilation stream, the moisture removed by an AC unit, the mixed outlet state from two air streams, or the Coefficient of Performance of a cooling cycle. Mastering this topic ensures you can confidently navigate air-conditioning scenarios – from reading a point on the psychrometric chart to calculating how many kW or Btu/hr an HVAC system must supply or remove. Let's break down the key principles, step by step, so you know exactly which formulas and moves to use on exam day (and avoid the common pitfalls that trip up others).

K11.T10.S01 – Psychrometric Air Treatment Processes
(Heating, Cooling, Humidification, Dehumidification, Mixing)

Principle Introduction: Moist air processes can be visualized on a **psychrometric chart** (a graphical plot of air properties at a constant pressure, usually 1 atm). Each basic process moves the air state on this chart in a characteristic way:

- **Sensible Heating/Cooling:** Changing dry-bulb temperature without changing moisture content (humidity ratio). On the chart, this moves a point **horizontally** – to the right for heating (temperature rises) or left for cooling – along a line of constant humidity ratio. Relative humidity changes (heating lowers RH, cooling raises RH), but absolute moisture stays the same.
- **Humidification/Dehumidification:** Adding moisture (e.g. by spraying steam/water) or removing moisture (e.g. by condensation). Pure humidification at constant dry-bulb temperature moves a point **vertically up** (ω increases) on the chart. Pure dehumidification at constant dry-bulb moves **down** (ω decreases). In practice, moisture changes often accompany some temperature change as well.
- **Cooling with Dehumidification:** A common combined process in AC cooling coils. Air is cooled *beyond its dew-point*, so water vapor condenses out. On the chart, the state point moves **down-left** – temperature drops and humidity ratio decreases. Initially it moves left (cooling) until reaching saturation (100% RH), then continues downward along the saturation curve as moisture condenses. Both sensible and latent heat are removed.
- **Heating with Humidification:** Common in winter HVAC systems (heating air and adding steam). The point moves **up-right** – temperature increases and moisture content increases. Both sensible heat and moisture are added.
- **Mixing of Air Streams:** When two air streams mix (e.g. return air with outside air), the resulting state lies **on the straight line** connecting the two initial states on the psychrometric chart. The mix point's position along that line depends on the mass flow proportions of the streams. No external heat is added; the process is essentially adiabatic mixing, so total enthalpy is conserved (neglecting any heat exchange to surroundings).

Exam Handbook Search Cues (Not affiliated with or endorsed by NCEES): psychrometric chart; humidity ratio; relative humidity; wet-bulb; adiabatic mixing; saturation curve; dew-point temperature; evaporative cooling

Footnotes:

- *Pressure Assumption:* Psychrometric charts and formulas assume standard atmospheric pressure (1 atm). If not stated, the FE exam problems typically use 1 atm for air-conditioning calculations. Significant deviation in pressure (e.g. high altitude) would alter the chart, but that's beyond exam scope.
- *Humidity Ratio Units:* The humidity ratio ω is a dimensionless ratio (mass of water per mass of dry air). On charts it's often given in units like $\mathrm{kg_{water}/kg_{dry\ air}}$ (or $\mathrm{lb_{water}/lb_{dry\ air}}$). Remember that 0.010 (dimensionless) means 0.010 kg of water vapor per 1.0 kg of dry air (i.e. 10 g/kg). It is not a percentage – don't mistake 0.010 for 1%!
- *Enthalpy Reference:* Moist air enthalpy values h (typically in kJ/kg dry air) are measured from a reference (0 °C for water liquid, etc.). You don't need to memorize reference details, but be consistent: use the values or charts given. Enthalpy of moist air includes both the dry air sensible heat and the latent heat of contained water vapor.
- *Relative vs. Specific Humidity:* **Relative humidity φ** is a pressure-based saturation percentage, while humidity ratio ω is a mass ratio (kg water vapor per kg dry air). **Humidity ratio ω** is the actual moisture content by mass. High φ doesn't always mean a lot of moisture – cold air at 90% RH can have less absolute moisture than warm air at 50% RH. The exam may give RH and T, and you might need to find ω or vice versa – the psychrometric chart or formulas connect these (ω formula: $\omega = 0.622\,\frac{P_v}{P_a} \approx 0.622\,\frac{P_v}{P-P_v}$ at 1 atm).
- *Wet-Bulb and Adiabatic Process:* The **wet-bulb temperature (T_{wb})** is the temperature measured when water evaporates into the air (cooling it). On the chart, lines of constant wet-bulb slope diagonally, roughly paralleling enthalpy lines. An *adiabatic humidification* (evaporative cooling) process moves the state along a line of nearly constant enthalpy (and constant T_{wb}) – air cools while picking up moisture, ending at a state with lower dry-bulb T and higher ω but roughly the same total energy (the air's sensible heat lost equals the latent heat gained by evaporated water). Keep in mind: if you see "evaporative cooler" on the exam, think **adiabatic humidification** – no external heat added.

Variations and Related Forms:

- **Combined Processes:** Real HVAC devices often do multiple things at once (cool & dehumidify, heat & humidify). For analysis, you can often treat them in steps (e.g. cool sensibly to the dew-point, then condense moisture). But using total enthalpy change in one go is usually faster and less error-prone, as the psychrometric chart encourages.
- **Mixing Calculations:** Instead of reading the mixture state from a chart, you can compute it. For two streams mixing adiabatically: dry-air mass conservation $m_{a3} = m_{a1} + m_{a2}$; humidity ratio $m_{a3}\,\omega_3 = m_{a1}\,\omega_1 + m_{a2}\,\omega_2$; and enthalpy $m_{a3}\,h_3 = m_{a1}\,h_1 + m_{a2}\,h_2$. From these, you can solve for unknown exit conditions. A shortcut: the mixture's humidity ratio and enthalpy are **mass-weighted averages** of the inputs. For quick estimates, plot the points on the chart and draw the line – the intersection with the straight line will be the mixture (proportional distance based on relative mass flow).
- **Typical Values:** Comfortable indoor air might be ~24 °C and 50% RH (ω ≈ 0.010). Cooling coils often cool air to ~12–14 °C and ~100% RH (saturation) to wring out moisture, then reheat slightly. In exam problems, if you calculate an outlet state with RH over 100% or a negative humidity ratio, that's a red flag – it means something's gone wrong (or you've found that cooling must have hit saturation).

Special Notes – Calculator Tips: For psychrometric problems, you likely won't be crunching huge formulas but rather reading values and doing linear calculations. Still, keep your units straight. If using IP units (°F, lbm, Btu), remember to convert heat flow to consistent units (Btu/hr to Btu/s, etc.) before using Q = m·Δh (lbm/s * Btu/lbm = Btu/s). Also, store intermediate values (like h1, h2) in your calculator's memory to avoid re-reading or rounding errors if you got them from a chart. On TI calculators, you can use the memory variables (A, B, C, ...) to save enthalpy or humidity values and reuse them in the Q = m*(h2 - h1) computation swiftly.

Explanation & Analysis: Let's walk through what these processes mean physically and how to handle them on the FE Exam. **Sensible heating or cooling** problems are straightforward: no moisture change. That means you use only the dry air's heat capacity (if doing it by formula $Q = mc_p\Delta T$) or, more generally, the enthalpy change of the air. For example, if 1 kg/s of air goes from 20 °C to 40 °C (no humidity change), the required heat Q is simply the mass flow times the increase in enthalpy of the air. Often, it's easiest to get those enthalpies from the exam's psychrometric chart or tables: at 20 °C, h might be around 28 kJ/kg; at 40 °C, around 50 kJ/kg (just rough numbers), so $Q \approx 1\ \text{kg/s} \times (50 - 28)\ \text{kJ/kg} = 22\ \text{kJ/s}$. In US units, you'd do the same with Btu/lbm values. The key recognition on the exam is **"no humidity change"** – that cues you to keep ω constant and just find the enthalpy change corresponding to the temperature change (sensible heat only).

When **humidifying or dehumidifying**, remember that *latent heat* is involved. If a question says air is humidified from ω_1 to ω_2, you know water is added. If no heat is supplied (adiabatic humidifier), the energy to evaporate that water comes from the air itself – causing the air to cool (constant enthalpy process). If instead a steam injector or heater is used to add moisture without cooling the air, then you're adding both moisture and heat. In calculations, dehumidification (like in a cooling coil) often goes hand-in-hand with cooling. The exam problem might give initial and final conditions including moisture change and simply ask for total heat removed – **don't double count** sensible and latent; just take the total enthalpy difference. This is where using $Q = m(h_2 - h_1)$ shines: the enthalpy values already include both the sensible and latent components for the air mixture. For instance, air at 30 °C and 50% RH has an enthalpy around (say) 85 kJ/kg dry air. If it's cooled and dehumidified to 15 °C and 90% RH, enthalpy might drop to ~40 kJ/kg. If 2 kg/s of dry air flow through, the cooling coil must remove $Q = 2 * (40 - 85) = -90$ kJ/s (negative sign meaning heat taken out; magnitude 90 kJ/s). That 90 kJ/s includes both the cooling of air and the condensation of water. You could separately calculate the latent portion (mass of water condensed * 2500 kJ/kg) and sensible portion ($m \cdot c_p \cdot \Delta T$) – and those should sum to the same Q. But why do double work? The enthalpy difference captured it in one step.

For **mixing problems**, use conservation principles. A typical exam question might give two air streams (one warm and dry, another cool and humid) mixing in an HVAC system and ask for the resulting humidity or temperature. The safest approach: set up the equations I mentioned in "Variations." However, if time is short and the answers are far apart, a graphical or estimation approach can work: you know the mixture state lies between the two states. It will be closer to the state of the larger mass flow. For example, if 1 kg/s of air at 40 °C, 10% RH mixes with 3 kg/s at 20 °C, 80% RH, the mixture will be dominated by the larger second stream – so the answer should be nearer 20 °C than 40 °C, and nearer 80% RH than 10% RH. You could eliminate options that don't make sense (e.g., any mixture temperature above 40 or below 20 °C would be impossible). If precision is needed, though, do the math: find ω_3 from $\omega_3 = \frac{\dot{m}_1\omega_1 + \dot{m}_2\omega_2}{\dot{m}_1 + \dot{m}_2}$, and h_3 similarly by weighted average. Then read off the corresponding T_3 and RH_3 from the chart if needed. One thing to watch: **mixing is adiabatic** (no heat loss to surroundings, unless stated). If the problem says the mixing is insulated or just silent on heat exchange, assume adiabatic – total enthalpy in = enthalpy out. If they mention a temperature drop during mixing without moisture change, that implies some heat was lost (non-adiabatic mixing), but that's unusual for FE.

To sum up, get comfortable with the psychrometric chart layout and remember these key moves: horizontal line = sensible heat change; vertical line = moisture change; diagonal or curved path = both. The exam handbook provides the chart and most formulas, so practice finding data on it quickly (like locating the enthalpy scale, the ω lines, etc.). Usually, the biggest mistakes are unit mix-ups (like forgetting to convert a flow rate to per-second) or misreading the chart. But conceptually, if you imagine what's happening to the air (**hotter/colder? wetter/drier?**), you can usually sanity-check your results. I've seen many students get tripped up by overthinking – but if you identify the process type, the solution often boils down to a simple energy balance or proportion. Keep it simple, follow the straight lines (sometimes literally on the chart!), and you'll navigate these questions with confidence.

K11.T10.S02 – Heating/Cooling Load Calculations (Psychrometric Method)

Principle Introduction: This subtopic is about quantifying the **heat transfer required** to achieve a desired change in air conditions. Whether it's a furnace heating air or a cooling coil chilling and dehumidifying it, the go-to principle is an **energy balance** on the air stream using the **enthalpy change of the air**. The core formula can be stated simply as: *heat transfer rate = mass flow rate × change in enthalpy of air*. In symbols, $Q = \dot{m}_a\,(h_{out} - h_{in})$. This applies to both heating and cooling processes – just be mindful of the sign (Q is positive for heating added to air, negative if heat is removed from the air). Key points to remember:

- We use **dry air mass flow rate** $\dot{m}_a$ (mass of dry air per time) when using moist air enthalpies h on a per-dry-air basis. This way, the moisture changes are automatically accounted for in the h values.
- The enthalpy difference $(h_{out} - h_{in})$ inherently includes both **sensible heat change** (temperature change) and **latent heat** (if moisture content changes). There's no need for separate formulas for latent and sensible heat – one enthalpy difference covers all.
- This calculation assumes a steady flow (open system steady-state) with no other significant energy inputs like shaft work. Essentially, it's a First Law application: the heat going into the air equals the increase in enthalpy of the air (or heat removed equals enthalpy decrease).

Equation Passport: *Heating/Cooling Load Equation – computes the required heat transfer rate to achieve a desired air state change.*

$$Q = \dot{m}_a\,(h_{out} - h_{in})$$

- **Q** – Heat transfer rate to the air (energy per time). Use SI or USCS units consistently (e.g. kJ/s which is kW, or Btu/s). Positive Q for heating (energy added to air), negative Q for cooling (energy removed from air).
- $\dot{m}_a$ – Mass flow rate of *dry air* (e.g. kg/s or lbm/s). Dry air mass is used because the moist air enthalpy h is usually per unit dry air. Sometimes problems give volumetric flow (m³/s or CFM); convert to mass flow using air density.
- $h_{in},\ h_{out}$ – Specific enthalpy of the moist air at inlet and outlet conditions (e.g. $\mathrm{kJ/kg_{dry\,air}}$ or $\mathrm{Btu/lb_{dry\,air}}$). These enthalpies correspond to the total heat content of the air *and its water vapor*. You can get them from the psychrometric chart or an appropriate formula/table.

Assumptions & Scope: 1) Applies to steady-flow HVAC processes (no accumulation of energy in the air; the air flows through at a constant rate). 2) No external work interactions (fans/blowers work is usually small relative to thermal changes and often neglected unless specifically included). 3) Any water that condenses or is added is accounted for in h values – if water mass leaves or enters separately, we use the enthalpy per dry air so that $\dot{m}_a$ and Δh automatically include that effect. 4) The process can be heating, cooling, humidifying, dehumidifying, or any combo – as long as you correctly pick h_{in} and h_{out}, this equation holds. (If there is a *mixing* of two streams, use a mixing equation instead – this formula assumes one inlet stream and one outlet stream for the control volume.)

Limit Checks (Sanity Tests): If $\dot{m}_a = 0$, then $Q = 0$ (no air, no heat needed – trivial case). If there's no change in enthalpy ($h_{out} = h_{in}$), then $Q = 0$ (as expected: if the air's state doesn't change, you didn't add/remove heat, barring transient storage). As $|h_{out} - h_{in}|$ grows large (big temperature or moisture change), the required Q increases linearly – double the Δh, double the Q. These make sense. Always watch the sign: if you accidentally swap h_{in} and h_{out} or forget that a cooling process yields a negative Δh, you might get a sign reversed. A quick physical check – "Am I expecting heat to be removed or added?" – can save you from an answer that's off by a sign.

Use vs. Sibling Equations: Use this energy balance instead of splitting into separate equations for sensible and latent heat **when the problem gives you psychrometric data or a chart**. It's simpler and less error-prone. Alternatively, you *could* use $Q = \dot{m}_a c_{p,\mathrm{air}} \Delta T$ for the dry-air sensible part and $Q = \dot{m}_{\mathrm{water}}\ h_{\mathrm{fg}}$ for the latent part, then sum them – but determining $\dot{m}_{\mathrm{water}}$ (water condensed or added) is an extra step, and you'd need the latent heat value h_{fg}. The single enthalpy method skips directly to the answer. In summary, **use $Q = \dot{m}\Delta h$ instead of separate "sensible heat" and "latent heat" equations, whenever you have moist air enthalpies handy.**

Common Exam Traps: - Unit Mix-Ups: Ensure the enthalpy values and mass flow are in matching units. For instance, if enthalpy is in kJ/kg, $\dot{m}$ must be kg/s to get kJ/s (kW). If you use Btu/lbm and CFM, convert CFM to lbm/s (using air density ~0.075 lbm/ft³ at standard conditions) or convert everything to consistent units. Watch out for problems giving flow in **CFM (ft³/min)** – convert to ft³/s then to lbm/s.

- Using Total Mass Instead of Dry Air Mass: If the problem directly gives a *moist air* mass flow (including water), it's usually so close to dry air mass that you can use it. But if there's significant moisture removal, the dry air mass flow remains constant while total mass flow might change slightly. Stick to dry air basis – it's consistent. The exam is unlikely to require accounting for the tiny difference, but conceptually remember: water condensing out doesn't change $\dot{m}_a$.

- Forgetting Sign Conventions: It's easy to misinterpret what sign of Q to report. Usually, if asked "how much cooling is required," they expect a positive magnitude for heat removed. If you compute $Q = -50$ kW from the formula, you might say "50 kW of cooling (heat removed)." A negative result simply indicates direction (heat out of air). State your answer in words if needed to avoid confusion (e.g. "50 kW of cooling" or "50 kW of heat must be removed").

- Mismatched Reference or Inlet/Outlet: Another trap is accidentally using the wrong enthalpy values – say, using the enthalpy at 100% RH when the air is actually at 50% RH, or grabbing the wrong line on a chart. Double-check you're reading h_{in} and h_{out} for the correct states. Each state is defined by two independent properties (like T and RH, or T and ω). Make sure you use both to pinpoint the enthalpy.

Exam Handbook Search Cues (Not affiliated with or endorsed by NCEES): enthalpy difference; heating load; cooling load; psychrometrics (energy balance); Btu/hr; kW; mass flow rate; humidity ratio (for latent heat)

Explanation & Analysis: When tackling an HVAC load problem, start by clearly identifying the **inlet** and **outlet** air states. For example, "Air enters at 30 °C, 60% RH and leaves at 15 °C, 90% RH." From those, determine h_{in} and h_{out}. The exam will either provide a psychrometric chart (where you find enthalpy by locating the point) or give you enough info to use an approximation or table. The difference $h_{out} - h_{in}$ tells you how much energy each kilogram of dry air has gained or lost. Next, identify the **mass flow rate** of air. Sometimes it's given directly (e.g. "500 kg/hour" or "1000 cfm"). Convert it to a convenient unit (kg/s or lbm/s). Now it's a simple multiplication.

Let's say the exam asks: *"A heating system takes in air at 10 °C with negligible moisture and heats it to 30 °C. If the flow rate is 2 kg/s, how much heating power is needed?"* You'd note no moisture change, so $\Delta h = c_p \Delta T$ for dry air. Using $c_p \approx 1.0$ kJ/kg·K (a rough value given in the handbook), $\Delta h \approx 1.0 * (30 - 10) = 20$ kJ/kg. Thus $Q = 2 * 20 = 40$ kJ/s, i.e. 40 kW. If more precision is needed, the psychrometric chart might show enthalpy ~ 10 kJ/kg at 10 °C and ~30 kJ/kg at 30 °C (just illustrative), yielding the same 20 kJ/kg difference.

For a cooling with dehumidification example: *"Moist air at 28 °C, 50% RH is cooled to 14 °C, 100% RH at 1 atm. Airflow 1.5 kg/s (dry air). Find the cooling rate in kW and the water removal rate."* Approach: find h_{in} at 28 °C, 50%. From the chart, maybe $h_{in} \approx 60$ kJ/kg. At 14 °C, 100% (saturated), $h_{out} \approx 40$ kJ/kg (cooler and drier air has lower enthalpy). Then $Q = 1.5\,(40 - 60) = -30$ kJ/s, meaning 30 kWof heat must be removed. The negative sign just indicates cooling. For the water removal: we could find $\omega_{in}$and ω_{out}(say $\omega_{in} \approx 0.010$, $\omega_{out} \approx 0.005$, just guessing from a chart). The difference 0.005 kg water/kg dry air, times 1.5 kg dry air/s, gives 0.0075 kg water/scondensed (that's 7.5 g/s). The heat associated with just that condensation is 0.0075 kg/s $\times$ 2500 kJ/kg ≈ 18.75 kW, which is part of the 30 kWtotal (the rest ≈ 11.3 kWis the sensible cooling part). Notice we didn't have to calculate that split for the answer – only if they specifically ask for water rate or sensible vs latent breakdown. Typically, the exam might only ask for the total cooling load (30 kW). But it's good to understand what's going on: part of the cooling went into condensing water (latent), part into dropping the temperature (sensible).

In any such problem, **draw a quick sketch or write down the states**, then apply $Q = \dot{m}(h_{out} - h_{in})$. It's a one-liner that packs a punch. If you're given weird units, convert them upfront. If given a volumetric flow like CFM, recall at standard conditions 1.0 kg dry air ≈ 0.833 m³ (this can vary, and the handbook has air density listed). For a ballpark, 1000 cfm is ~0.47 m³/s; with air at 1.2 kg/m³, that's ~0.56 kg/s of air. Get to mass flow, multiply by Δh.

Finally, keep an eye out for wording: "heat required to warm the air" implies a positive Q (your answer might be phrased as "XX kW of heat input"). "Cooling load" implies how much heat is removed (you might answer "YY kW of cooling" or "YY kW heat removed"). If the number you calculate is negative, you can just state the magnitude as the cooling load. The exam grader isn't interested in the sign as much as the understanding – but writing "-50 kW" without context could be risky. Safer to say "50 kW removed". And of course, double-check that your answer makes sense: if you're cooling 1 kg/s of air by 10 K, expecting around 10 kJ/s (10 kW) of cooling, and you got 100 kW, something's probably off by a factor of 10 (maybe you forgot that 1 kg/s is a lot of air – actually 1 kg/s is 3600 kg/hour, which is quite a high flow – always contextualize the numbers!). Use your physical intuition and the straightforward formula, and these questions become some of the quickest points you can score on the exam.

K11.T10.S03 – Refrigeration & HVAC Cycles (Overview and Connection to Air Processes)

Principle Introduction: This subtopic ties together the thermodynamic cycle behind refrigeration (cooling systems) with the HVAC processes we've discussed. The **refrigeration cycle** – typically a vapor-compression cycle – is what provides the cooling in an air conditioner or refrigerator. Key components (compressor, condenser, expansion device, evaporator) work in concert to move heat from a low-temperature space (your cooled air stream) to a high-temperature sink (outdoor air). For the FE Exam, you should grasp the basics: how the cycle transfers heat, what the **Coefficient of Performance (COP)** is, and how it relates to efficiency. Also, be aware of common metrics like a **"ton of refrigeration."** While you won't be asked to design a refrigeration cycle, you might need to calculate a COP or recognize how improving one part of the cycle affects performance, or simply understand that the evaporator is the part that cools and dehumidifies the air in an HVAC system. Think of the refrigeration cycle as the *engine* driving the air-conditioning process: it's the reason the cooling coil is cold and can absorb heat (and moisture) from the air.

Definition/Note Passport: Coefficient of Performance (COP) – The COP is the key performance measure for refrigerators and heat pumps, defined as the heat transferred divided by the work input. It tells us how effectively a refrigeration cycle uses work to transfer heat.

- **Plain-language definition:** *COP is how many units of heat you get moved per unit of work you put in.* For a cooling device (refrigerator/AC), COP = (heat removed from the cold space) / (work input). For a heat pump (heating device), COP = (heat delivered to the warm space) / (work input). It's like an "efficiency" but can be greater than 1.
- **Where it matters (exam impact):** You may be asked to compute COP given cooling or heating rates and compressor work, or to use COP to find one of those values. Also, knowing the difference between the COP of a refrigerator vs a heat pump is important (which heat is in the numerator). Sometimes an FE problem might give you an "ideal COP" (Carnot COP) to compare against an actual COP.
- **Pitfall or confusion point:** Don't mix up which heat goes on top! A common mistake is to put the wrong Q in the ratio. Remember: for refrigeration/AC, it's the **cooling effect** (heat taken from cold space) over work; for heat pump, it's the **heating effect** (heat released to hot space) over work. Also, COP is typically unitless (since it's a ratio of energies). And note, a higher COP is better (more cooling per work). COP can be greater than 1, which surprises some people used to efficiencies <100% – but there's no violation of physics, since we're moving heat, not converting it from work alone.
- **Micro-check:** True or False? *If a refrigerator's COP is 4.0, that means it removes 4 times more heat from the cold space than the electrical work it consumes.* – **True.** (For example, 1 kW of compressor work would remove 4 kW of heat from the fridge interior, while rejecting 5 kW to the environment.)

Equation Passport: *Coefficient of Performance* – for refrigerators and heat pumps (vapor-compression cycle devices).

$$** \; COP_{\text{ref}} = \frac{Q_L}{W_{\text{in}}}, \qquad COP_{\text{HP}} = \frac{Q_H}{W_{\text{in}}} \; **$$

- $\boldsymbol{COP_{ref}}$– COP for a refrigerator or air conditioner (cooling mode). Q_L is the heat removed from the low-temperature side (the cooling coil/evaporator, which cools the air), and W_{in} is the work input to the cycle (usually the compressor work). This formula gives how effective the AC is at cooling for the power input.
- $\boldsymbol{COP_{HP}}$ – COP for a heat pump (heating mode). Q_H is the heat delivered to the high-temperature side (the condenser, which in heating mode warms the space), over the same work input. Numerically, $COP_{HP} = COP_{ref} + 1$ because $Q_H = Q_L + W$ by energy balance (the heat pump delivers both the absorbed heat and the work as useful heating).
- Q_L – Heat absorbed by the evaporator (the "cooling" provided). For an air conditioner, this is the heat taken out of the indoor air. Units: kJ/s (kW) or Btu/hr, etc.

- Q_H – Heat rejected by the condenser (the "heating" delivered in heat pump mode). This is the heat dumped to the outside air for an AC, or delivered inside for a heat pump.
- W_{in} – Work input to the cycle (typically the electrical power to the compressor).

Assumptions & Scope: This COP definition assumes a steady cyclic operation in a **vapor-compression refrigeration cycle**. No need to delve into refrigerant details on the FE – just treat the cycle abstractly. We assume all heat transfers Q_L and Q_H are at roughly constant temperature reservoirs (to use the Carnot efficiency concepts if needed). The formulas given are generic and do not depend on the working fluid details. The exam may provide a COP or ask for one; typically, it won't require derivation from temperatures, but you should know Carnot COP as a theoretical max: $COP_{Carnot}^{ref} = \frac{T_L}{T_H - T_L}$ (with T in absolute units). Real systems have lower COPs. We also assume here single-stage cycles; if you encounter a two-stage or cascade, the problem will likely give you enough info or ask conceptually which has better COP, etc., but that's rare at FE level.

Typical Values: A well-performing air conditioner might have a COP around 3 to 4 (which corresponds to an EER of ~10–14 in US units). That means for each 1 kW of electricity, it removes 3–4 kW of heat from the room. A Carnot refrigerator operating between, say, 5 °C (278 K) and 35 °C (308 K) would have a COP max of $278/(308 - 278) = 9.3$. Real systems are much lower due to irreversibilities. Heat pumps can achieve COPs of 3–5 in moderate climates (delivering 3–5 times more heat than the electric power input). Also remember **1 ton of refrigeration = 12,000 Btu/hour = 3.516 kW**. If a problem gives cooling load in "tons," convert it to kW or Btu/hr for calculations. (E.g., a 2-ton AC = 7.032 kW of cooling.) This conversion might be handy to recall on exam day.

Common Exam Moves: - If given cooling load and asked for compressor power, you'll use $W = \frac{Q_L}{COP}$. For example, *"An AC provides 5 kW of cooling at COP 2.5, what is the input power?"* Answer: $5/2.5 = 2$ kW.

- If given COP and asked for heats, you might use $Q_H = Q_L + W$ (First Law for the cycle). For instance, *"A heat pump with COP 3.0 delivers 18,000 Btu/hr to a house. How much work does it consume?"* We have $COP_{HP} = Q_H/W$, so $W = Q_H/COP = 18000/3 = 6000$ Btu/hr of work (which is about 1.76 kW). And it would absorb $Q_L = Q_H - W = 12000$ Btu/hr from outside (incidentally 12000 Btu/hr is 1 ton of cooling from the outside air).

- Sometimes the exam may present a slightly tricky scenario like asking *"What happens to COP if the indoor coil temperature is lowered further?"* Conceptually, if T_L drops or T_H rises, the Carnot COP limit drops – meaning the device has to work harder (COP decreases). Or they may ask about improving performance: e.g., *"How could one increase an AC's COP?"* – Answer: reduce the temperature lift (bring the condenser temperature down or evaporator temperature up, i.e., make indoor coil warmer or outdoor coil cooler, or improve components to reduce losses).

Linking to HVAC Processes: It's crucial to connect that the **evaporator** in the refrigeration cycle is the component that actually **performs the cooling and dehumidification of air**. In subtopic S01, we talked about cooling coils removing both sensible and latent heat from air – that is exactly Q_L for the refrigeration cycle. The evaporator is a cold heat exchanger; as warm, moist air passes over it, the air cools (sensible cooling) and moisture condenses on the coil (latent removal). The heat absorbed (sucked out of the air) is carried away by the refrigerant as latent heat of evaporation. The cycle then uses a compressor to pump that heat (plus the work added) to the condenser, where it's dumped outside. So when you calculate an HVAC cooling load in kW, that essentially is Q_L the refrigerant cycle must handle. If the problem gives you an HVAC scenario with a certain load and asks for compressor power or COP, you bridge these topics: use the load as Q_L, apply the COP formula.

For example, *"An auditorium needs 100 kW of cooling. If the chiller (AC system) has COP 4.0, estimate the electrical power required."* You'd do $W = 100/4.0 = 25$ kW. Or vice versa, maybe they tell you the input power and ask for cooling capacity. Another scenario: *"A 5-ton air conditioner is running. How much heat is it rejecting to the outdoors if its COP is 3.0?"* First convert 5 tons to 5*3.516 = 17.58 kW of cooling (that's Q_L). With COP 3, the work $W = 17.58/3 = 5.86$ kW. The heat rejected outside $Q_H = Q_L + W = 23.44$ kW, which in tons is about 6.67 tons of heat dumped (since 1 ton = 3.516 kW). So the outdoor unit actually expels more heat than the cooling provided indoors – which makes sense, it's the sum of cooling plus the electrical work turned into heat. This kind of understanding can be tested qualitatively or quantitatively.

Exam Handbook Search Cues (Not affiliated with or endorsed by NCEES): COP; refrigeration cycle; heat pump; Carnot COP; ton of refrigeration; evaporator; condenser; vapor-compression

Special Notes: When using your calculator, if a COP problem involves temperatures, make sure to convert to absolute (Kelvin or Rankine) for any Carnot COP formula. For instance, entering $\frac{T_L}{T_H - T_L}$ – if you plug 5 °C and 35 °C directly, that's wrong; convert to 278 K and 308 K. Also, be cautious with efficiency vs COP. Sometimes efficiency (%) might be given for a compressor, but the COP is different. If a compressor is, say, 80% efficient and ideal COP was 5, actual COP might be 0.8*5 = 4 (if all other losses ignored). The FE probably won't go that deep, but just keep concepts straight: the "efficiency" of a refrigerator usually refers to COP compared to Carnot COP. And one more tip: don't confuse power and energy. COP is a ratio of heat* rates* to power (both in consistent units of power). If a question gives energies (e.g. Btu or Joules) instead of rates, the ratio of those over a cycle is the same COP. Just ensure you don't mix an energy with a power.

Explanation & Analysis: The refrigeration cycle is essentially the **reverse of a heat engine**. Instead of producing work from a temperature difference, we consume work to *create* a temperature difference – pulling heat from a cold place and dumping it to a hot place. On the exam, the most important piece of this puzzle for mechanical HVAC is the **Coefficient of Performance (COP)** and understanding which heat is relevant for the scenario. If you're dealing with an air conditioner or refrigerator question, you're in the $COP_{ref} = Q_L/W$ world: you care about the cooling output Q_L. If it's a heat pump supplying heat to a house, it's $COP_{HP} = Q_H/W$.

A quick way to remember: *"Refrigerator = remove heat from Low, Heat Pump = deliver heat to High."* In both cases, the denominator is the work input. It's easy to handle these problems if you systematically list what's given and what's asked: identify Q_L, Q_H, W and COP. Write down the two basic relations: $COP = Q_{desired}/W$ and $Q_H = Q_L + W$ (energy conservation in the cycle). With those, you can solve any of the algebraic puzzles they throw. For instance, an exam question might hide two of these three variables in wording: "A heat pump draws 2 kW of power and delivers 6 kW of heat to the house. What is its COP and how much heat is it extracting from outside?" Here, $W = 2kW, Q_H = 6kW$.

$COP_{hp} = 6/2 = 3$. And $Q_L = Q_H - W = 4kW$ from outside. Sometimes, they might give COP and one of the heats, and you find the other heat or the work. It's just plug and play.

Another consideration: **Carnot COP**. If they mention an ideal or Carnot refrigerator, and give you two temperatures (say the cold space and ambient), you might need to use $COP_{Carnot} = \frac{T_L}{T_H - T_L}$. Remember to use absolute temperatures. This formula basically comes from the efficiency of a Carnot engine, and its inverse for a heat pump. If a question asks "what is the maximum possible COP" for given temps, that's when you use Carnot. E.g., "What's the best COP an air conditioner could have operating between 5 °C evaporator and 35 °C condenser?" Plug $T_L = 278$ K, $T_H = 308$ K: $\mathrm{COP}_{\mathrm{Carnot}} \approx \frac{278}{308-278} = \frac{278}{30} \approx 9.3$. Real world will be lower. If the actual COP is given, you could be asked for a second-law efficiency (i.e. actual COP / Carnot COP). But those are more likely in the thermo section; still, it's good to see the connections.

Linking back to HVAC: if you computed in S02 that the building needs 100 kW of cooling, you now know if your chiller has COP 4, you'll consume 25 kW of electricity. If COP was only 2, you'd need 50 kW input – meaning a less efficient AC draws more power for the same cooling. Environmentally and economically, higher COP (efficient AC) is better. On exam problems, you might see this as a comparison: *"Given two AC units, one with COP 2.5 and one with COP 3.2, how many fewer kW will the better unit use for a 5-ton cooling load?"* You'd calculate the power for each and subtract. It's a straightforward application once you recognize it's a COP scenario.

Finally, understand qualitatively **what each component does**: Compressor (adds work, raises refrigerant pressure and temperature), Condenser (rejects heat Q_H to outside, refrigerant condenses), Expansion valve (drops pressure/temp without energy exchange, cooling the refrigerant), Evaporator (absorbs heat Q_L from the air, cooling and dehumidifying it). They might throw a conceptual question like *"Where in the cycle does the refrigerant have the lowest entropy?"* or *"Why does water condense on the evaporator coils?"* For FE, the latter is more likely – answer: because the coil surface is below the dew-point of the air, so moisture in air condenses out, which is how dehumidification occurs. Or *"What change would increase the moisture removal by an AC system?"* – lowering the evaporator temperature will remove more moisture (but also use more energy; COP drops). These links between thermo cycle and air processes are fair game conceptually.

To wrap up: when you see a problem about an air conditioning cycle, first decide if it's asking about the **cycle performance (COP, work, heat)** or the **air side (cooling load, moisture)** or both. Then apply the appropriate tool: use COP and energy balance for the cycle; use psychrometric enthalpy for the air side. And if they mix them – e.g., "An AC cools 2 kg/s of air from X to Y. What compressor power is needed if COP is Z?" – you now have the skills to tackle it: find the cooling Q from air side ($\dot{m}\Delta h$), then divide by COP to get work. That's the bridge between these topics. With practice, you'll recognize these patterns quickly. And remember, **not affiliated with or endorsed by NCEES** – but the knowledge here is aligned with what you need for the FE Mechanical. You've got this – stay cool under pressure (pun intended) and the HVAC questions will be a breeze.

Topic 11 - Combustion and Combustion Products

Topic Introduction: Combustion and its products form a core thermodynamics topic on the FE Mechanical Exam. This area covers how to *balance fuel combustion equations*, how to *quantify the energy released* when fuels burn, and how to apply the **First Law** of thermodynamics to reacting systems. You'll see questions asking for oxygen or air required to burn a fuel, computing the heat released or absorbed in a combustion reaction, or finding the outcome of a combustion energy balance (like an adiabatic flame temperature or heat loss). Mastering this topic means you can confidently handle problems involving fuel chemistry and energy conservation in combustion processes – a frequent scenario on exam day. Typical questions might give a hydrocarbon fuel and ask for the stoichiometric air-fuel ratio, the reaction enthalpy using given formation data, or the effect of combustion energy on system temperatures. In all cases, a structured approach (balance the reaction, apply energy formulas) will lead you to the correct answer efficiently.

K11.T11.S01 – Fuel Combustion Chemistry (Stoichiometric Combustion Equations)

- **Balancing Fuel Reactions:** Combustion of a hydrocarbon means reacting it with oxygen to produce carbon dioxide and water. On the FE, you'll usually assume **complete combustion** (all carbon → CO_2 and hydrogen → H_2O) unless told otherwise.
- **Stoichiometric Oxygen Requirement:** *Stoichiometric* means just enough oxygen (or air) to completely burn the fuel with no oxygen left over. You find this by balancing the chemical equation – essentially counting how many O_2 molecules are needed. A common mistake is to guess; instead, use a systematic balance: balance C atoms first, H second, and O last.
- **Including Air (N_2):** Air is about 21% O_2 and 79% N_2 by volume (or 23% and 77% by mass). For every mole of O_2 from air, roughly 3.76 moles of N_2 come along for the ride (because 79/21 ≈ 3.76). Nitrogen doesn't combust; it's inert in the reaction, but it will appear on both sides of the equation as unchanged N_2. If a problem says "air" instead of pure oxygen, remember to add N_2 to the equation on the reactant side (and it will just flow through to products).
- **Finding Air–Fuel Ratios:** Once the equation is balanced, you can compute the **air–fuel ratio**. This can be expressed on a **molar basis** (moles of air per mole of fuel) or a **mass basis** (mass of air per mass of fuel). The stoichiometric air–fuel ratio is particularly important – it's the minimum air required. If you supply more air (i.e. "excess air"), not all oxygen is consumed; if you supply less, you get *incomplete combustion* (with CO or unburned fuel as products).
- **Exam Tip:** Often you'll be given a fuel formula like CH_4 or C_8H_{18} and asked for something like "theoretical air required" or "percent excess air". Write the balanced equation, extract the O_2 needed per mole of fuel, then convert that to air if needed. Keep track of units: typically, you might express the answer in terms of mass (kg of air per kg of fuel) or moles, depending on what the question specifies.

Equation Passport: Stoichiometric Combustion Equation – computes the required oxygen (and air) to completely burn a hydrocarbon fuel to CO_2 and H_2O.

- **Balanced Reaction (general hydrocarbon):**

$$C_aH_b + \left(a + \frac{b}{4}\right) O_2 \;\rightarrow\; a\,CO_2 + \frac{b}{2}\,H_2O$$

(If using air instead of pure O_2, include nitrogen: e.g. $C_aH_b + \left(a + \frac{b}{4}\right) O_2 + 3.76\left(a + \frac{b}{4}\right) N_2 \rightarrow a\,CO_2 + \frac{b}{2}\,H_2O + 3.76\left(a + \frac{b}{4}\right) N_2$.*)*

Variables and units:

- a – number of carbon atoms in the fuel molecule (dimensionless count).

- b – number of hydrogen atoms in the fuel molecule (dimensionless count).

- The coefficient $a + \frac{b}{4}$ – moles of O_2 required per mole of fuel (derived from balancing C and H).

- Coefficients for products: a moles of CO_2 and $b/2$ moles of H_2O per mole of fuel.

- For air: the factor 3.76 multiplies O_2 moles to account for accompanying N_2 in air (mole-based ratio).

Assumptions and scope:

- Fuel is a pure hydrocarbon (contains only C and H). This formula assumes no oxygen, nitrogen, sulfur, etc. in the fuel. If other elements are present (e.g. oxygen in an alcohol, sulfur in coal), the combustion equation must include their oxidation products (like SO_2 for sulfur) and the required O_2 will differ.

- Complete combustion: All carbon burns to CO_2 and all hydrogen to H_2O. No CO, soot, or other partial products are formed (this is the *theoretical ideal* when enough oxygen is supplied).

- Steady-state reaction with constant proportions – we're not tracking time or kinetics, just the initial and final amounts. Pressure and temperature don't affect the coefficients for balancing (they do affect phases of H_2O, but not the count of molecules needed).

- Nitrogen in air is inert (does not react) and appears unchanged in products. We assume air is just O_2 + N_2 (ignoring minor components like argon).

Limit tests (sanity checks):

- If $b = 0$ (fuel has no H, e.g. pure carbon as C_1H_0), the formula gives $C + 1O^2 \rightarrow 1CO^2$. This makes sense: one O_2 per carbon.

- If $a = 0$ (no C, hypothetical fuel like H_2 which is C_0H_2), the formula gives $H_2 + 0.5O^2 \rightarrow H^2O$. That checks out: hydrogen needs half an O_2 to form one water.

- More hydrogen in the fuel (larger b) increases the O_2 required, but not as drastically as more carbon does on a per-atom basis: hydrogen's O_2 requirement is $b/4$ per fuel molecule (because 2 H atoms share an O atom in H_2O). An extreme case: very hydrogen-rich fuel like H_2 itself still uses relatively little O_2 per H (0.5 O_2 per H_2).

- As you increase the fuel size a, b proportionally (e.g. C_2H_4 vs C_1H_2, which are essentially the same ratio), the O_2 per fuel molecule increases in the same ratio. The *per-carbon* O_2 is ~1 and *per-2 hydrogen* O_2 is 0.5, always. These constant needs per atom help double-check your balancing.

Use vs. sibling equations: Use this balanced reaction method instead of memorizing fuel-specific O_2 requirements. It works for any hydrocarbon. If oxygenated fuels or incomplete combustion are involved, you'll modify the equation to include those cases (e.g. include CO in products for incomplete combustion or less O_2 than stoichiometric). But for the **FE exam**, questions will typically either assume complete combustion or explicitly state otherwise. In summary, use this stoichiometric equation to find the theoretical air requirement, then adjust for any "excess air" by simply adding extra O_2 (and corresponding N_2) on the reactant side that will remain unreacted on the product side.

Common exam traps:

- **Fractional O_2 coefficients:** It's perfectly fine to have a fraction for O_2 (like 0.5) in the balanced equation, but many students think they must avoid it. If it bothers you, multiply the entire equation through by 2 to eliminate halves. Just be cautious: multiplying through changes the basis (2 moles fuel instead of 1), which is fine as long as you stay consistent. The air-fuel ratio or O_2 per fuel will be the same either way.

- **Mixing up O_2 vs O:** Remember that O_2 is the diatomic oxygen molecule. If your count of oxygen atoms comes out to, say, 4 per fuel molecule, that means 2 O_2 molecules (because each O_2 has 2 O atoms). Always count **atoms on products** and halve to get O_2 molecules required. A common error is to equate oxygen atom count directly to O_2 count. For example, propane C_3H_8 yields $3CO^2 + 4H^2O$; that's $3 * 2 + 4 * 1 = 10$ O atoms in products, hence 5 O_2 needed (not 10 O_2!).

- **Forgetting the nitrogen:** If the question specifically mentions "air," don't leave N_2 out in the balanced equation if you need to report the total *mass* of air. Nitrogen adds a lot of mass (about 3.3 kg of N_2 per 1 kg of O_2). An exam question might ask "how much air (not just O_2) is needed" – include the N_2 by multiplying the O_2 moles by 4.76 to get the air moles (since air is ~21% O_2 by volume). Similarly, on a mass basis, the stoichiometric mass air-fuel ratio will use O_2's mass plus N_2's mass.

- **Excess vs. theoretical air:** If a problem says "20% excess air," that means the actual air provided is 120%of the theoretical requirement. It's easy to accidentally compute only 20%of the requirement or misunderstand the phrasing. A quick way: $\%\text{ excess air} = \frac{\text{actual}-\text{stoich}}{\text{stoich}} \times 100\%$. So, actual air $=$ stoich $\left(1+\frac{\%\text{ excess}}{100}\right)$. Double-check you're adding, not multiplying or some other mix-up.

- *Incomplete combustion cases:* If the exam presents a scenario with limited air, some carbon will form CO instead of CO_2. Don't panic: balance it by introducing CO as a product. For example, "incomplete combustion of carbon" might yield CO instead of CO_2. Each CO only consumes 0.5 O_2 (C + 0.5 O_2 -> CO), whereas CO_2 consumes a full O_2 (C + O_2 -> CO_2). These details are usually provided or hinted at in the question stem if needed.

Exam Handbook Search Cues (Not affiliated with or endorsed by NCEES): *combustion, stoichiometric, air–fuel ratio, excess air, incomplete combustion* (These are typical keywords to find reference info in the exam's handbook if needed – e.g. look for "Combustion Processes" for formulas like air–fuel ratio or definitions of theoretical air.)

Footnotes:
1. The term "stoichiometric" is often synonymous with "theoretical" in this context. **Theoretical air** means the minimum O_2 (or air) needed with no leftover O_2. **Percent theoretical air** is the ratio (actual O_2 supplied)/(stoichiometric O_2) × 100%. **Percent excess air** is just percent theoretical air minus 100%.
2. Balancing tip: *"CH O"* – Many instructors suggest balancing *C*, then *H*, then *O* in that order, as a memory aid (sounds like "CHO" or *choo*). It ensures you leave oxygen last since O_2 is often easier to adjust after C and H are set. If you have other elements (S, N in fuel), include them in the sequence appropriately (e.g. C, H, S, then O).

Variations and related forms: For non-hydrocarbon fuels, the combustion equation extends similarly. For example, an alcohol like ethanol C_2H_5OH has oxygen in it, so it requires less O_2 from the air (some O is already in the fuel). You'd include its internal oxygen when balancing: $C_2H_5OH + 3O_2 \rightarrow 2CO_2 + 3H_2O$ (notice it needed 3 O_2 instead of $2 + b/4 = 2 + 6/4 = 3.5$ because the fuel contributed one O atom). Also, if **sulfur** is in the fuel, add SO_2 as a product (each S needs one O_2 to become SO_2). If **nitrogen** is in the fuel (like some amines or certain coals), it typically ends up as N_2 in products (assuming complete combustion without forming NO_x at the temperatures considered for equilibrium).

Explanation & Analysis (Step-by-Step): Let's walk through balancing a typical combustion problem to solidify the process:

1. **Identify the fuel formula and assume products:** Suppose the fuel is **propane, C_3H_8**. On exam day, you recognize this as a hydrocarbon (contains C and H only). For complete combustion, *assume products will be CO_2 and H_2O.* So start writing:

$$C_3H_8 + O_2 \rightarrow CO_2 + H_2O.$$

2. **Balance Carbon:** Propane has 3 carbons, so you need 3 CO_2 to carry all 3 carbons into products. Update the equation:

$$C_3H_8 + O_2 \rightarrow 3CO_2 + H_2O.$$

3. **Balance Hydrogen:** Propane has 8 hydrogens. These will form water. Each H_2O has 2 H, so to use 8 H you need 4 H_2O (because 4 * 2 = 8 H). Update the products:

$$C_3H_8 + O_2 \rightarrow 3CO_2 + 4H_2O.$$

4. **Balance Oxygen last:** Now count oxygen atoms on the product side. You have 3 CO_2 which contain $3 * 2 = 6$ O atoms, and 4 H_2O which contain 4 O atoms (4 * 1 each). Total O atoms in products = 6 + 4 = 10. These must come from O_2 on the reactant side. Each O_2 has 2 O atoms, so the number of O_2 molecules needed is 10/2 = 5. Thus, put 5 O_2 on the reactant side:

$$C_3H_8 + 5O_2 \rightarrow 3CO_2 + 4H_2O.$$

Now carbons, hydrogens, and oxygens are all balanced.

1. **Check your work:** 3 C on left vs 3 C on right (good). 8 H left vs $4 * 2 = 8$ H right (good). O: $5 * 2 = 10$ O left vs $3 * 2 + 4 * 1 = 10$ O right (good). The equation is balanced.

2. **Interpret the result:** The balanced equation tells you *one mole of C_3H_8 needs 5 moles of O_2* for complete combustion. If the question asks for the **stoichiometric air-fuel ratio** by mass, convert that: 5 moles O_2 is part of air, so 5 moles O_2 corresponds to $5 * 3.76 = 18.8$ moles of air (including N_2). In terms of mass: 5 moles O_2 is $5 * 32 = 160$ g of O_2. The accompanying N_2 is 18.8 - 5 = 13.8 moles N_2 (actually we got 18.8 total, of which 5 are O_2, so 13.8 N_2). 13.8 moles N_2 is $13.8 * 28 = 386.4$ g N_2. Total air mass = 160 + 386.4 = 546.4 g. The fuel was 1 mole of C_3H_8, which is 44 g (C_3H_8 molar mass 12*3* + *8*1 = 44). So mass air-fuel ratio = 546.4/44 ≈ 12.4 (unitless ratio, e.g. kg air per kg fuel since grams/grams). This is the theoretical (stoichiometric) air-fuel ratio for propane. If the problem gave options around 12, you'd be confident in that answer. *(Note: Many fuels have known A/F ratios: e.g. gasoline ~14.7:1 by mass. Propane's we found ~12.4:1 which seems reasonable because propane is a bit more hydrogen-rich than typical gasoline, thus needs slightly less air by mass.)*

3. **Excess air adjustments:** If instead the problem said "Propane is burned with 20% excess air," you would compute the theoretical O_2 (5 moles per mole fuel as we did), then multiply by 1.2 (to account for 20% extra). That gives 6 moles O_2 actually used. The balanced equation with excess air would be:
$$C_3H_8 + 6O_2 \rightarrow 3CO_2 + 4H_2O + (\text{extra } O_2 \text{ left over}).$$
In practice, you'd show the leftover O_2 on the products side: after the 5 O_2 do their job, 1 O_2 remains unreacted:
$$C_3H_8 + 6O_2 \rightarrow 3CO_2 + 4H_2O + O_2.$$
And if dealing with air, also carry through the N_2: 6 O_2 comes with $6 * 3.76 = 22.56$ N_2 in, and the same 22.56 N_2 out. The presence of O_2 in products indicates incomplete usage (excess air). On the exam, you might not need to write out this whole thing, but understanding that *excess air means oxygen appears in products unused* is key to solving related problems (like calculating percent O_2 in flue gas, etc.).

By following a structured approach to balancing and interpreting the combustion equation, you'll handle these questions quickly and avoid common pitfalls. It becomes almost mechanical with practice – and that's exactly what you want under exam pressure, a reliable method to get the right coefficients every time.

K11.T11.S02 – Enthalpy of Combustion and Fuel Heating Values

- **Heat of Reaction vs. Heat of Combustion:** When a fuel burns, it releases heat – we call this the *enthalpy of combustion* (or heat of combustion). It's essentially the enthalpy change ΔH of the combustion reaction, usually measured at standard conditions (25°C, 1 atm) for a specified amount of fuel (per mole or per unit mass). If ΔH is negative, the reaction is exothermic (releases heat). Combustion reactions are almost always exothermic, so you'll see negative enthalpy changes indicating the system lost enthalpy (and heat was given off to the surroundings).
- **Standard Enthalpies of Formation:** A practical way to calculate the enthalpy change of any reaction (including combustion) is by using **standard enthalpies of formation (ΔH_f°)** for each compound. The enthalpy of formation is the heat change associated with forming one mole of a compound from its constituent elements in their standard states. By definition, elements in standard state (like O_2 gas, N_2 gas, graphite carbon) have $\Delta H_f^\circ = 0$. The enthalpy of *reaction* can be obtained by subtracting the total formation enthalpies of reactants from that of products (essentially applying Hess's Law on formation reactions).
- **Formula for Reaction Enthalpy:** For a reaction $\sum \nu_i \text{Reactant}_i \rightarrow \sum \nu_j \text{Product}_j$, the enthalpy change is $\Delta H_{rxn}^\circ = \sum_j \nu_j \, \Delta H_{f,j}^\circ - \sum_i \nu_i \, \Delta H_{f,i}^\circ$, where ν are stoichiometric coefficients (take products as positive, reactants as positive in their sum as well, effectively subtracting reactants' enthalpy). This formula will likely be given or easily derivable from data provided on the exam.
- **Heating Value of Fuels:** The *heating value* is a practical measure of the energy content of a fuel. It's basically the magnitude of the heat of combustion, typically given in energy per mass (e.g. kJ/kg) or per mole for common fuels. There are two flavors: **Higher Heating Value (HHV)** and **Lower Heating Value (LHV)**. The difference lies in the state of water in products: HHV assumes water formed is **condensed to liquid**, releasing its latent heat, whereas LHV assumes water remains **vapor** in the products (so the latent heat of vaporization isn't recovered). HHV is therefore larger than LHV for the same fuel (because HHV counts that extra heat). For instance, hydrogen fuel has a huge difference between HHV and LHV (water formation releases a lot of condensation heat), whereas for a coal (mostly carbon) the difference is smaller (since producing CO_2 involves no water).
- **Using Heats of Combustion in Problems:** On the FE, you might get a problem where you're given the heat of combustion (or a heating value) directly, to find how much heat is released when burning a certain amount of fuel. In those cases, simply multiply the heating value by the amount of fuel. *Be mindful of units:* if given in kJ/kg and you have mass in kg, multiply to get kJ. If given per mole, convert moles accordingly. Alternatively, you may be given tables of ΔH_f° and asked to compute ΔH_{rxn} for a combustion reaction. Make sure to use the balanced equation coefficients in that calculation. And remember: if the question asks for "heat **released**", they expect a positive answer for an exothermic reaction (even though ΔH calculated would be negative). For clarity, you might say "magnitude of heat released = XYZ kJ".

Equation Passport: Reaction Enthalpy via Formation – calculates the net enthalpy change of a chemical reaction (like combustion) using standard enthalpies of formation for reactants and products.

Reaction Enthalpy Formula:

$$\Delta H_{\text{rxn}}^\circ = \sum_{products} n_p \, \Delta H_f^\circ(\text{prod}) - \sum_{reactants} n_r \, \Delta H_f^\circ(\text{react}),$$

where the summations run over all products and reactants, and n refers to the stoichiometric coefficients (in moles) for each species as given in the balanced reaction. (It's good practice to include the sign of ΔH°_{rxn} as positive for endothermic and negative for exothermic by the result of this formula.)

Variables and units:

- $\Delta H^\circ_{\text{rxn}}$ – standard enthalpy change of the reaction, in energy per mole of reaction as written (often kJ per mole of reaction, where "mole of reaction" means the molar amounts in the balanced equation). Sometimes it's reported per mole of *fuel* combusted, which is a specific case especially for combustion reactions. Units typically kJ/mol or kJ/(mol of fuel).

- $\Delta H_f^\circ(\text{X})$ – standard enthalpy of formation of species X, usually given in kJ/mol. By convention, ΔH_f° for pure elements in their stable form (O_2 gas, N_2 gas, C (graphite), etc.) is 0 kJ/mol. For compounds, ΔH_f° can be negative (exothermic formation) or positive (endothermic formation).

- n_p, n_r – stoichiometric coefficients for products and reactants, respectively. For example, in $CH_4 + 2O_2 \rightarrow CO_2 + 2H_2O$, $n_r(CH_4) = 1, n_r(O_2) = 2, n_p(CO_2) = 1, n_p(H_2O) = 2$. These should be dimensionless (pure numbers of moles). Ensure you use the coefficients from a *balanced* equation.

- Note: It's crucial to apply the coefficients to the enthalpies of formation. Missing a coefficient is a common mistake. Also, pay attention to states of substances – ΔH_f° for H_2O (l) vs H_2O (g) are different, reflecting the latent heat. If the reaction produces water vapor but you accidentally use ΔH_f° for liquid water, your answer will be off by the condensation heat (~+44 kJ/mol water at standard conditions). The exam problem usually specifies or implies whether water is liquid or vapor in the products.

Assumptions and scope:

- All reactants and products are at standard reference state (25°C, 1 atm) *for the purpose of computing* ΔH_f°. This doesn't necessarily mean the reaction occurs at 25°C in reality, but the tabulated values of ΔH_f° are referenced to that. If the reaction occurs at a different temperature, this formula gives the enthalpy change between reactants and products both at 25°C. Any additional heating/cooling to or from that temperature would be handled separately (see subtopic 3 for energy balance considerations).

- Reaction goes to completion as written, and there are no side reactions. We assume a fixed set of reactants and products. If something like "some CO instead of CO_2" is present, you'd treat CO as a product in the equation and include its formation enthalpy accordingly.

- Pressure is low enough (or ideal gas behavior assumed) such that ΔH is not a strong function of pressure. Standard enthalpies are given at 1 atm, but reactions at a few atm won't change these values significantly for our purposes.

- The formula is basically an application of Hess's Law. We assume we can linearly combine formation reactions to get the reaction of interest. This is valid because enthalpy is a state function (path independent and additive for reactions when reversed or summed).

Limit tests:

- **No reaction scenario:** If the products and reactants are identical sets (e.g. a "reaction" that is just the same substances, or if you accidentally write reactants = products), then each species' enthalpy of formation cancels out and $\Delta H_{rxn} = 0$. This makes sense: no change, no enthalpy change.

- **Elements only forming an element:** If you had something like O_2 -> 2 O (just dissociation, not typical in exam combustion context), the formation enthalpies would show O_2 = 0 (reference), O atoms have a positive formation enthalpy (since forming atomic O from elements is endothermic). Using the formula would correctly give you ΔH_{rxn} equal to that enthalpy needed to break O_2. So it works for decomposition too if you treat it formally.

- **Reversing reactions:** If you reverse a combustion reaction (which would represent splitting CO_2 and H_2O back into fuel and O_2 – a highly endothermic process), the sign of ΔH_{rxn} flips. The formula inherently does that if you swap what you call reactant and product. So $\Delta H_{combustion}$ for fuel is -(ΔH_f of fuel plus etc… minus elements). For example, methane combustion might have $\Delta H_{rxn} = -890$ kJ/mol (exothermic). If you looked at the formation of methane from CO_2 and H_2O, you'd get +890 kJ/mol (endothermic) – which checks out since that's basically the energy needed for synthesis like photosynthesis in reverse.

Use vs. sibling equations: Use this **formation enthalpy method** whenever you have a list of formation enthalpies or a table of heats of formation in the problem. It's straightforward and reliable. Alternatively, if the problem directly provides a **heat of combustion value** (for example, "the heat of combustion of octane is 5470 kJ/mol"), you could use that directly instead of summing formations. That given combustion heat is essentially the $-\Delta H_{rxn}$ for burning 1 mole of fuel under specified conditions. So, **use the given heating value** if available – it saves time and reduces calculation error. Only fall back to summing enthalpies of formation if you need to derive it or if you're asked to show the calculation. Both approaches yield the same result if done correctly (neglecting minor rounding).

- Another "sibling" concept is using **bond energies** to estimate reaction enthalpy. That's more of a chemistry approach and is generally less accurate; for the FE, you'd rarely do that since data tables for formation enthalpy or direct combustion enthalpy are provided. Stick with formation enthalpies or given heats of combustion rather than bond energies unless a question specifically leads you there.

Common exam traps:

- **Sign errors (exothermic vs endothermic):** Probably the #1 mistake. Remember that if a reaction releases heat (exothermic combustion), the numerical value you get from the formula will be negative (because the enthalpy of the products is lower than that of reactants by that released amount). If a question asks "how much heat is released," they likely expect a positive answer in terms of magnitude (e.g. "500 kJ are released"). Pay attention to wording: if they say "find the enthalpy change ΔH for the reaction," you can give a negative number with units (e.g. -500 kJ). If they say "how much heat is evolved," you'd say "500 kJ (released)". In summary, don't mix up the sign convention. It helps to explicitly note to yourself: **negative ΔH = exothermic = releases heat**.

- **Forgetting to multiply by coefficients:** The formation enthalpy of CO_2 might be, say, -393.5 kJ/mol. If your reaction produces 3 CO_2, you must do $3 * -393.5$ in the sum. It's easy under time pressure to drop a coefficient. A quick remedy: write out a little

table of species, coefficients, and ΔH_f values, then multiply and sum – this reduces the chance of leaving something out.

- **Mixing up product/reactant order in the formula:** A classic slip is to do reactants minus products instead of products minus reactants. One way to avoid this is to derive it yourself each time in a mini-way: "formation of products minus formation of reactants" – literally think of building products from elements and subtracting the cost of building reactants from elements. Alternatively, remember that it's final minus initial in terms of enthalpy content (products final state, reactants initial state). If you accidentally invert it, you'll get the opposite sign. You can often catch this by expecting an exothermic sign for combustion; if you got a positive ΔH for burning methane, you know something went wrong because burning fuels should release heat (negative ΔH).

- **Wrong reference for elements:** As mentioned, elements in standard state have $\Delta H_f = 0$. Students sometimes plug in data for O_2 or N_2 given in tables not realizing those might already be zeros or they might confuse ΔH_f with something else. Double-check: The formation enthalpy of O_2 (g) is zero by definition (it's an element in standard form). If a table lists something for O_2, it might be entropy or Gibbs energy etc., not enthalpy of formation. Don't add a spurious number for elemental oxygen. Similarly, N_2 (g) is zero. These zeros effectively simplify your calculation since any term for O_2 or N_2 reactants will drop out.

- **Not matching states (LHV vs HHV issue):** If water is produced in a combustion and the problem's data assumes liquid water (which would be HHV scenario) but in reality, if the problem context says "products are gaseous," you might need to use the formation enthalpy for H_2O gas or subtract the latent heat. Most often, the exam will be clear or provide the needed values. Just remember: $\Delta H_f^\circ[H_2O\ (l)] \approx -286$ kJ/mol, $\Delta H_f^\circ[H_2O\ (g)] \approx -242$ kJ/mol. The difference ~44 kJ/mol is the condensation heat. If you use the wrong one, your answer will be off by about that much times the moles of water. So be mindful of phrases like "water vapor" vs "water liquid" in the combustion context.

Exam Handbook Search Cues (Not affiliated with or endorsed by NCEES): *heats of formation, heat of combustion, enthalpy of reaction, heating value* (In the exam reference, look for a section on "Heats of Reaction…Formation, and Combustion" for a conceptual overview, and any table of fuel properties if provided. But typically the exam gives you the needed values in the question.)

Footnotes:

1. The terms **"heat of combustion"**, **"enthalpy of combustion"**, and **"heat of reaction (for a combustion)"** are used interchangeably in many contexts. Just note heat of combustion usually implies the *magnitude* of heat released (a positive number in kJ/mol fuel, for example), whereas enthalpy change ΔH would be negative for the same process. Some sources tabulate heats of combustion as positive values by convention (assuming the "heat evolved" is positive). Always clarify what sign convention is being used.

2. **Fuel Heating Values:** Common fuels and their heating values (approximate): Methane ~50,000 kJ/kg (LHV ~ 50,000, HHV ~ 55,500 kJ/kg), Gasoline ~44,000 kJ/kg, Coal (varies, ~24,000 kJ/kg), Hydrogen ~120,000 kJ/kg (LHV, HHV is much higher ~142,000 kJ/kg because of water condensation). The exam might give a value or ask relative comparisons. Recognize that hydrogen has the highest energy per mass (but low per volume), and that hydrocarbons are in the 44-55 MJ/kg range typically. You won't need to memorize exact numbers, but knowing orders of magnitude helps catch errors (e.g., if you compute 500 kJ/kg for a fuel, that's way too low; 50,000 kJ/kg is reasonable).

3. **Units Watch:** Formation enthalpies might be given in **kJ/mol** (per mole) whereas heating values might be **kJ/kg**. Always convert to consistent units when mixing data. If you have ΔH_f in kJ/mol, multiply by the molar amount of that species in your balanced reaction and by how many moles of reaction you are considering (often we do it per mole of fuel for convenience). **Unit conversion (molar ↔ mass basis):** (kJ/mol) = (kJ/kg)(kg/mol) = (kJ/kg) MFor propane, $M = 0.044$ kg/mol. Example: 46,400 kJ/kg × 0.044 ≈ 2,040 kJ/mol. If asked "how much heat is released by burning 2 kg of propane," and you're given a heating value (say 46,400 kJ/kg), then $Q \approx 46{,}400 \times 2 =$ 92,800 kJreleased (sign convention: ΔHwould be negative for combustion). Use the exact HHV/LHV values provided in the problem/reference rather than memorizing. The key is to use the right units in the right place.

Variations, related concepts: One related concept is **adiabatic flame temperature** – which is essentially using the entire heat of combustion to raise the temperature of products when there's no heat loss (we'll cover that in the next subtopic with energy balance). Another is the idea of **combustion efficiency**: not all the fuel's chemical energy might go into useful work or heat – but that's more of a machine concept (engines, boilers). Within pure thermodynamics, we assume if fuel burns completely, we harness all that enthalpy in either heating something or as work. Also, note that certain reactions have special names: *heat of combustion* (fuel + O_2 -> CO_2 + H_2O), *heat of formation* (elements -> compound), *heat of solution* (dissolving something), etc. They all follow similar calculation principles but don't confuse them. The exam might include a table in the reference with "Heats of formation/combustion" – use it as needed.

Explanation & Analysis: Let's illustrate calculating a combustion reaction enthalpy both by summing formation enthalpies and using a given heating value, to see the consistency.

Example: Calculate the heat released (in kJ) when 1 mole of propane (C_3H_8) is completely burned in oxygen at 25°C, producing CO_2 (g) and H_2O (l).

- **Step 1: Balanced equation.** From the previous subtopic, we have: $C_3H_8 + 5O_2 \rightarrow 3CO_2 + 4H_2O(l)$. (They specified water liquid, indicating we should use formation enthalpy for liquid water.)
- **Step 2: Get ΔH_f° values.** From a reference (these would be given in the problem or handbook): $\Delta H_f^\circ[C_3H_8(g)] = -104$ kJ/mol (propane gas formation from elements is slightly endothermic, or actually here it's given as -104 which would mean exothermic to form propane? Let's assume -104 is correct, meaning forming propane from C and H releases 104 kJ; anyway), $\Delta H_f^\circ[CO_2(g)] = -393.5$ kJ/mol, $\Delta H_f^\circ[H_2O(l)] = -285.8$ kJ/mol. And of course $\Delta H_f^\circ[O_2(g)] = 0$ (element).
- **Step 3: Apply the formula $\sum n_p H_f(products) - \sum n_r H_f(reactants)$.** Products: 3 CO_2 gives $3 * (-393.5) = -1180.5$ kJ; 4 H_2O (l) gives $4 * (-285.8) = -1143.2$ kJ. Sum of products = -2323.7 kJ. Reactants: 1 C_3H_8 = -104 kJ; 5 O_2 = $5 * 0 = 0$. Sum of reactants = -104 kJ. Now $\Delta H_{rxn}^\circ = (-2323.7) - (-104) = -2323.7 +$

$104 = -2219.7$ kJ per mole of C_3H_8 (approx).
So $\Delta H^{\circ}_{combustion} \approx -2220$ kJ/mol. The negative sign indicates exothermic (heat released). If the question asks "how much heat is released?", you'd say 2220 kJ per mole (released).

- **Step 4: Cross-check with a known heating value.** Propane's HHV is about 50.4 MJ/kg. 1 mole of propane is 44 g, or 0.044 kg. If we multiply 50.4 MJ/kg * 0.044 kg, we get 2.22 MJ, which is 2220 kJ. Bingo – it matches our calculation (assuming we used liquid water, which corresponds to HHV). If we had assumed water vapor, the value would be smaller (around 2044 kJ/mol), matching an LHV type scenario.
- **Step 5: Interpretation.** The reaction releases ~2220 kJ for every mole (44 g) of propane burned, when water is condensed. If a problem gave you 10 grams of propane to burn, you'd scale it: 10 g is 0.227 moles (10/44). Multiply 0.227 * 2220 kJ = ~503 kJ released. Always scale linearly with the amount of fuel.
- **Step 6: Using given data directly (if available).** If instead the problem directly stated "propane's heat of combustion is 2220 kJ/mol," you could skip directly to scaling with fuel amount. The formation enthalpy method just shows where that number comes from. On the FE, if they list formation enthalpies, they want you to use them; if they list a heat of combustion, they want you to use that. They likely won't make you derive one from the other unless it's a conceptual question about the difference (like HHV vs LHV or effect of water phase).

To summarize, mastering enthalpy of combustion calculations involves being comfortable with the sign conventions and methodically plugging into the formula. It's plug-and-chug once you have the data: get the numbers, multiply by coefficients, subtract, and interpret the sign. Keep track of units and states, and you'll be in good shape.

K11.T11.S03 – First-Law Analysis of Combustion Processes (Energy Balance for Reactive Systems)

Combustion & The First Law: The **First Law of Thermodynamics** (energy conservation) applied to a combustion process accounts for the chemical energy released by the reaction and how it translates into other energy forms. In plain terms: *the energy released by burning fuel either stays in the system as increased internal energy/enthalpy (raising temperature), does boundary work, or leaves as heat to the surroundings.* On the FE exam, you'll often assume no shaft work in simple combustion chambers, so the main balance is between the heat released by the reaction and the change in internal energy or enthalpy of the system (plus possibly any heat losses).

Two Common Scenarios:

- **Adiabatic combustion:** No heat is lost to the surroundings ($Q_{loss} = 0$). All the chemical energy goes into heating the products (and possibly doing expansion work if volume changes). A typical question here is finding the **adiabatic flame temperature** – the temperature of the combustion products when fuel and oxidizer react adiabatically. To solve, you set the chemical energy released equal to the increase in internal energy/enthalpy of the products. This often requires iteration or using given heat capacities, but conceptually it's straightforward: more fuel energy = higher final temperature.
- **Combustion with heat loss (or heat addition):** Sometimes you want to maintain a certain temperature, so excess energy is removed. For instance, in a boiler furnace, fuel burns but you don't want unlimited temperature rise; heat is absorbed by water/steam walls – that's a controlled **heat loss** from the combustion chamber which goes into steam generation. First Law handles this by distributing the energy: some goes into raising product enthalpy (temperature), the rest is carried away as heat transfer.

Energy Balance Equation (steady flow): A general steady-flow energy balance with one inlet (fuel + air) and one outlet (products) and neglecting kinetic/potential energy and shaft work is:
$\sum_{in} \dot{m}\ h_{in} + \dot{Q}_{in} = \sum_{out} \dot{m}\ h_{out} + \dot{Q}_{out} + \dot{W}_{shaft}$.
For a combustion chamber (reactor) with no shaft work and treating heat loss as $\dot{Q}_{out}$, this simplifies to:

$$\dot{m}_{\text{fuel}} h_{\text{fuel}} + \dot{m}_{\text{air}} h_{\text{air}} + 0 = \dot{m}_{\text{prod}} h_{\text{prod}} + \dot{Q}_{out} + 0.$$

However, the tricky part is that the fuel's *chemical energy* isn't explicitly in its sensible enthalpy h_{fuel} (if fuel enters at room temp, its sensible enthalpy is low, but it carries a lot of chemical potential energy). The secret is that the **enthalpies of products** already include the chemical reaction energy if you reference them via formation enthalpies. In other words, if you use absolute enthalpies (including formation) for each species, the above equation inherently accounts for reaction energy. If instead you work with *heat of reaction* as a separate term, you might write a form of the First Law as:
Energy released by reaction + sensible enthalpy of reactants + heat in = sensible enthalpy of products + heat out.

Practical approach: For exam purposes, you often use a *heat of reaction method*:

$$\text{Heat released by fuel} = \text{Increase in sensible energy of products} + \text{Heat losses.}$$

If no heat losses (adiabatic), then heat released by fuel = increase in energy of products. If there are losses, then products don't get as hot because some energy left as heat. This can be written in terms of enthalpy at constant pressure or internal energy at constant volume.

Constant-Volume vs Constant-Pressure: In a constant-volume closed bomb (no work done, W=0), all reaction energy goes into raising **internal energy (U)** and possibly heat if not adiabatic. At constant pressure (open system, like a flame at atmospheric pressure), reaction energy goes into raising **enthalpy (H)** and maybe PV work and heat losses. The distinction matters if you were doing detailed calcs, but the FE exam usually frames it as either a sealed container or an open system. In either case, you apply the appropriate form:

- Constant-volume adiabatic: $\Delta U_{products} = -\Delta H_{rxn}$ (no work, no Q out, so chemical energy becomes internal energy increase).
- Constant-pressure adiabatic: $\Delta H_{products} = -\Delta H_{rxn}$ (enthalpy increase equals heat of combustion, since pressure-volume work is accounted in enthalpy).

- With heat loss: $-\Delta H_{rxn} = \Delta H_{\text{products (sensible)}} + Q_{loss}$ for constant pressure (or $\Delta U + Q_{loss}$ for const vol). This is basically saying the released chemical energy is split into heating the products plus the heat that left.

Equation Passport: Combustion Energy Balance – relates the chemical energy from fuel to the change in thermal energy of the system and any heat loss, following the First Law of Thermodynamics. (This is a conceptual equation capturing the essence of the first law for reacting systems.)

- **Energy Balance (constant pressure form):**
  $-\Delta H_{\text{rxn}} = \Delta H_{\text{prod (sensible)}} + Q_{\text{loss}}$,

  where $-\Delta H_{rxn}$ is the heat **released** by the chemical reaction (a positive quantity for exothermic combustion), $\Delta H_{\text{prod (sensible)}}$ is the increase in enthalpy of the products (from initial conditions to final state), and Q_{loss} is the heat that leaves the system to the surroundings (if you instead have heat *added*, that term would be negative, but in combustion we usually talk about heat leaving as losses or cooling).

If analyzing a constant-volume (closed) combustion, replace H with U (internal energy) in the equation. The concept is analogous: $-\Delta U_{rxn} = \Delta U_{\text{prod}} + Q_{loss}$ at constant volume (though ΔU_{rxn} for a reaction would be based on internal energy change which is slightly different from enthalpy change by the PV work term; however, at low pressures and if all starting and ending at same T, $\Delta U_{rxn} \approx \Delta H_{rxn}$ minus $R\,\Delta nT$ for gases, but that detail is usually not needed unless specifically asked).

Variables and units:

- ΔH_{rxn} – Enthalpy of reaction (kJ per mole of reaction, typically). For a combustion, this is negative (exothermic), so $-\Delta H_{rxn}$ is a positive number representing energy released. If you use per mole of fuel, multiply by number of moles of fuel reacted in your scenario to get total energy.

- $\Delta H_{\text{prod (sensible)}}$ – The enthalpy increase of products, i.e. the difference between enthalpy of products at final state and what their enthalpy would be at the initial state (usually 25°C reference). Essentially $\sum n_p\left(h_{p,\,final} - h_{p,\,initial}\right)$. Units kJ (for total) or kJ/mol depending on normalization. Often this is computed via $\sum mc_p\Delta T$ if assuming constant specific heats or given average c_p. If multiple products, do that for each and sum.

- Q_{loss} – Heat lost to environment (kJ). If the combustion chamber loses heat, this term is positive on the right side. If instead the chamber is gaining heat from outside (rare in combustion context, but think of supplying heat to sustain a reaction), we'd treat that as negative Q_{loss} or a separate Q_{in} term on left. Units in kJ or kJ per time if a rate, but usually we do a batch or one reaction at a time on FE problems, unless it's phrased as a steady rate (then use kJ/s, etc, consistently).

- $\Delta U_{rxn}, \Delta U_{\text{prod}}$ – analogous internal energy terms if constant volume. Units kJ or kJ/mol. Remember $\Delta H_{rxn} = \Delta U_{rxn} + \Delta n_g RT$ for reactions where gas moles change; at 298 K, $\Delta n_g * RT$ (in kJ) can be calculated if needed, but usually differences between ΔH and ΔU are small relative to the magnitudes we deal with (and many exam problems ignore the distinction unless testing that concept explicitly).

Assumptions and scope:

- **Closed vs Open:** The provided equation is written for a constant-pressure process (open to atmosphere, no significant pressure rise) so it uses enthalpy. If the problem is a closed container (constant volume), use internal energy. The approach is similar but mind the slight difference: at constant volume, no PV work, so more energy stays as internal energy – an explosion in a rigid bomb runs hotter than one in a piston that can expand (because in the piston case some energy does PV work instead of raising temperature). The exam might qualitatively ask or expect you to know that constant-volume combustion yields higher temperatures than constant-pressure combustion from the same fuel, for this reason.

- **Adiabatic vs Non-adiabatic:** If it's adiabatic, $Q_{loss} = 0$. If not, Q_{loss} accounts for any heat transfer. Often in steady devices like combustors, some heat loss is present but sometimes negligible. The FE might include it to see if you can distribute energy correctly.

- **Complete combustion assumed:** The equation is easier to apply when all fuel reacts completely (so you have a definite ΔH_{rxn} per mole of fuel). If some fuel is unburned or partial, then you'd have to account for that in a more complex way (essentially the reaction enthalpy would be less because not all fuel reacted). Typically, exam problems assume complete combustion unless they explicitly say otherwise or give you an efficiency. If they say the combustion is, say, 90% complete, you might only release 90% of the full chemical energy. Combustion efficiency is sometimes given; you'd multiply $-\Delta H_{rxn}$ by that efficiency.

- **Negligible kinetic and potential energy changes:** We assume the flow's kinetic energy and any height differences are not significant in energy balance, which is valid for most combustion chamber analysis (unless it's a rocket nozzle problem – but that's more fluids than this context).

- **Steady state (for open systems):** For open flow reactors, assume steady flow so that there's no accumulation of energy in the control volume over time (the products carry away what the reactants brought, plus or minus heat). For closed systems, assume the process goes to completion and then you look at initial vs final states.

Limit checks:

- **All energy to heating (adiabatic):** Set $Q_{loss} = 0$. Then $-\Delta H_{rxn} = \Delta H_{prod}$. If $-\Delta H_{rxn}$ is, say, 1000 kJ, that means the products' enthalpy increased by 1000 kJ. If you have 1 kg of products with a certain specific heat capacity, you could estimate the temperature rise. As a check, more fuel energy (bigger $-\Delta H_{rxn}$) or less mass (like limiting how much inert nitrogen is around) should yield a higher temperature rise – which fits intuition. If you got the opposite, you likely put numbers in wrong places.

- **No temperature rise (isothermal combustion with heat loss):** If the products end up at the same temperature as reactants (say 25°C initial and 25°C final, which is conceptually the definition of the standard heat of combustion scenario), then $\Delta H_{\text{prod sensible}} = 0$ (no sensible change). The equation reduces to $-\Delta H_{rxn} = Q_{loss}$. That means all the chemical energy was removed as heat – consistent with doing it in a calorimeter that absorbs the heat to keep temperature steady. It's a good extreme case to remember: if you see a problem where reactants and products are at the same T, the heat of reaction must have gone into some heat transfer or work.

- **Fuel energy vs oxygen supply:** If no oxygen, no reaction, no energy. If you double the fuel (and oxygen accordingly), you double the energy release. So the equation should scale linearly with the amount of fuel reacted. If you accidentally square something or take a wrong ratio, you might get a non-linear result which would be a red flag.

Use vs. related equations: This energy balance is essentially the First Law. Use it in combustion contexts instead of the simpler $Q = mc\Delta T$ which doesn't account for chemical energy. If there's no reaction (like just heating air), then it simplifies to $Q = mc\Delta T$. But with reaction, always include the $-\Delta H_{rxn}$ term or ensure your enthalpies are referenced properly. Another related concept is **Hess's Law** or using enthalpies of formation directly in energy balance: sometimes, instead of explicitly writing $-\Delta H_{rxn}$, you include formation enthalpies in initial and final enthalpies. Either way works if consistent. On the exam, stick to whatever method the problem seems to guide you towards. If they provide enthalpy values at different temperatures, you might sum a sensible heating part and a reaction part. If they provide an adiabatic flame temperature table or something, use that.

Common mistakes:

- **Ignoring the reaction term:** A frequent error is to do a heat balance without accounting for the chemical energy. For example, say you try to find flame temperature by equating $m_{air}c_{air}\Delta T + m_{fuel}c_{fuel}\Delta T = 0$ or something – that would ignore that fuel releasing, say, 50,000 kJ/kg is the dominant term. Always identify if a chemical reaction is providing energy; if yes, include that energy.

- **Wrong reference states for enthalpy:** If you use tabulated enthalpies that already include formation (like enthalpy of CO_2 at 1500 K relative to elements at 0K, etc.), be careful not to add ΔH_{rxn} on top of that or you'd double count. Conversely, if you use only sensible heat capacities from 25°C upward, then you must add the reaction enthalpy separately. In summary, don't mix methods accidentally. A safe approach in many FE problems is: take all reactants from 25°C to reaction conditions, add reaction enthalpy at that temp, then cool products from that temp to 25°C – set sum = 0 for adiabatic. This is conceptually how you'd solve for final T. But practically, they may simplify it by giving average c_p or ignoring small differences.

- **Mixing up sign conventions:** This bears repeating – ensure the signs in your energy balance are consistent. If you take $-\Delta H_{rxn}$ to the right side, it becomes $+\Delta H_{rxn}$ on left, etc. A good way: start from first law form $Q_{in} - Q_{out} + \sum mh_{in} = \sum mh_{out}$. For adiabatic combustion in open system: 0 + $m_{fuel}LHV + m_{air}h_{air,in}$ = $m_{prod}h_{prod,out}$. The fuel's LHV (lower heating value) is effectively $-\Delta H_{rxn}$ (positive number if you plug it in as energy input). That clarity helps. If the result you get for Q_{loss} comes out negative in your calculation, it means it's actually heat *input* (or you assumed loss in wrong direction). Double-check the scenario: negative Q_{loss} would mean you need to add heat to make the numbers match, which could happen in an endothermic scenario or if products are somehow hotter than fuel could achieve (which shouldn't happen with combustion alone). Usually, for combustion, either $Q_{loss} = 0$ or a positive number.

Exam Handbook Search Cues (Not affiliated with or endorsed by NCEES): *combustion energy balance, adiabatic flame temperature, reactive systems first law* (While the handbook may not spell out the full narrative, it contains First Law formulas and mentions reactive systems; knowing these terms will help you find any relevant equations or data quickly during the exam.)

Footnotes:

1. **Adiabatic Flame Temperature:** This is a term you should know – it's the temperature achieved by the products of combustion when no heat is lost (adiabatic) and no work is done. It's usually the maximum temperature possible for given reactants. Common values: for hydrocarbon-air mixtures, adiabatic flame temps are on the order of 2000–2500 K. If you ever calculate one and get, say, 5000 K, likely an error, because dissociation and other effects would kick in anyway (not in FE scope). Roughly, 2200 K (about 1900 °C) is a ballpark for many fuels in air at stoichiometric mix. If excess air is used, flame temperature drops (because the extra air is like ballast, absorbing heat). If the mixture is fuel-rich (not all fuel can burn due to lack of O_2), flame temperature might also be lower because some energy is locked in unburnt fuel or partial products and because combustion might be incomplete.

2. **Constant Volume vs Constant Pressure:** In a rigid container (constant volume), none of the energy goes into expansion work, so it all stays as internal energy – leading to a higher temperature rise. In a constant pressure scenario (like an open flame), some energy is spent pushing back the atmosphere as the products (at higher temperature) occupy more volume; thus a bit less energy goes into internal energy, and the temperature rise is slightly lower. For ideal gas combustion, $\Delta U_{rxn} = \Delta H_{rxn} - RT\Delta n$ (with Δn being the change in moles of gas). If more moles of gas are produced (as in hydrocarbon combustion, 1 fuel + some O_2 -> multiple CO_2 + H_2O molecules), ΔU_{rxn} will be a little less negative than ΔH_{rxn}. But unless specifically asked, you usually use ΔH_{rxn} because we tend to do constant-pressure analyses (or they give you data assuming that). If needed, the exam might have a conceptual question like "Which will have a higher temperature rise, constant-volume or constant-pressure combustion of the same mixture?" – answer: constant-volume, due to no PV work.

3. **Typical analysis on exam:** You might be given an initial and final temperature, and asked to find how much heat was lost or needed. For example: "Methane is burned with theoretical air in a steady-flow reactor. Reactants enter at 25°C, products leave at 1500 K. Find the heat transfer from the reactor." The way to solve: compute $-\Delta H_{rxn}$ for methane (at 25°C reference, with products at 25°C) which is 802 kJ/mol (methane to CO_2+H_2O (g) roughly). Then compute the enthalpy of products at 1500 K relative to 25°C (using heat capacity integrals or given values). The difference will tell you if there's excess energy. If the products at 1500 K have, say, absorbed 600 kJ of that energy (sensible), then the remainder ~202 kJ must have left as heat. If the products absorbed all 802 kJ (which would correspond to some higher adiabatic T, maybe ~2200 K), and you only got them to 1500 K, it means ~202 kJ was lost as heat to keep them cooler. This is a classic energy balance approach.

4. **Watch units and basis:** When doing these calculations, be consistent – either per mole of fuel or per some flow rate. If you do per mole, Q_{loss} comes out in kJ per mole fuel. If the question asks for total kJ/s and gives a fuel feed rate, you'd then multiply by the molar flow rate. It might be easier in steady flow problems to work in extensive terms (total kJ) from the start using mass or molar flow rates. But if not given, per mole or per 1 kg is fine to find an answer then scale.

Explanation & Analysis: Let's do a quick first-law analysis example to tie it all together:

Example: Octane (C_8H_{18}) is burned with **150% theoretical air** (i.e., **50% excess air**) in a steady-flow combustor. Both reactants (fuel and air) enter at **25°C**, combustion is complete, and the process is at **constant pressure**. If the products exit at **1200 K**, calculate the **heat transfer** from the combustor **per mole of fuel**. You are given $\Delta H^\circ_{\text{comb}}[\text{C}_8\text{H}_{18}(l)] = -5471$ kJ/mol fuel(for producing CO_2(g) and H_2O(v) at 25°C). With 150% theoretical air, the balanced reaction per mole of fuel is:

$$\text{C}_8\text{H}_{18}(l) + 18.75(\text{O}_2 + 3.76\text{N}_2) \rightarrow 8\text{CO}_2 + 9\text{H}_2\text{O} + 6.25\text{O}_2 + 70.5\text{N}_2.$$

Using sensible enthalpy increments from 25°C to 1200 K (from tables or as provided),
$\Delta h_{\text{sens},i}(1200) = \int_{298}^{1200} c_{p,i}\,(T)\,dT,$
the steady-flow energy balance (neglecting KE/PE and shaft work) becomes:

$$\frac{Q}{n_{\text{fuel}}} = \Delta H^\circ_{\text{comb}} + 8\,\Delta h_{\text{sens,CO}_2} + 9\,\Delta h_{\text{sens,H}_2\text{O}} + 6.25\,\Delta h_{\text{sens,O}_2} + 70.5\,\Delta h_{\text{sens,N}_2}.$$

(Plug in the provided $\Delta h_{\text{sens},i}$values to get Qin kJ/mol fuel; negative Qmeans heat leaves the combustor.)

Step 1: Write balanced equation with 150% air.
Stoichiometric for C_8H_{18}: $C_8H_{18} + 12.5O_2 \rightarrow 8CO_2 + 9H_2O$. (12.5 O_2 because 8 C need 8 O_2, 18 H need 4.5 O_2, total 12.5; yes that's a fraction – multiply by 2 for clarity: $2C_8H_{18}$ + 25 O_2 -> 16 CO_2 + 18 H_2O, but per mole fuel it's fine to keep 12.5.) With 150% air, actual O_2 = 1.5 * 12.5 = 18.75 O_2 per mole fuel. The extra O_2 will appear in products. Also bring N_2: Air has 3.76 N_2 per O_2, so N_2 in = 18.75 * 3.76 = 70.5 N_2 (moles). So the reaction is: $C_8H_{18} + 18.75O_2 + 70.5N_2 \rightarrow 8CO_2 + 9H_2O + 6.25O_2 + 70.5N_2$.(Notice 18.75 O_2 in, but only 12.5 O_2 needed, so 6.25 O_2 remains unused in products.)

Step 2: Compute $-\Delta H_{rxn}$ per mole fuel. They gave heat of combustion for liquid octane as -5471 kJ/mol. But careful: that is likely for combustion to CO_2 (g) + H_2O (l) at 25°C (often heats of combustion are given with water liquid to get HHV). Let's assume it's to CO_2 (g) + H_2O (l). However, our products at 1200 K include water vapor. The difference between water liquid and vapor is ~44 kJ/mol * 9 mol = ~396 kJ less heat release if water remains vapor. So the effective ΔH_{rxn} to CO_2 (g)+H_2O (g) might be about -5075 kJ/mol (5471-396). But also our reactants include octane liquid which we should confirm enters as liquid or gas? Let's assume liquid and it vaporizes during combustion – that's minor compared to reaction enthalpy, but okay. We'll go with -5075 kJ/mol fuel for reaction producing gaseous products at 25°C. Thus $-\Delta H_{rxn} = 5075kJ$ released per mole fuel (at reference).

Step 3: Calculate sensible enthalpy increase of products from 25°C to 1200 K. We need the enthalpy change for each product species from 25°C to 1200 K. Suppose (for simplicity) we have these values:
CO_2: ~+150 kJ/mol (to heat from 25°C to 1200K),
H_2O (g): ~+120 kJ/mol,
O_2: ~+100 kJ/mol,
N_2: ~+100 kJ/mol (these are rough estimates for illustration; actual might differ but order is a few hundred kJ).
Now multiply by moles:

- 8 CO_2 * 150 = 1200 kJ
- 9 H_2O * 120 = 1080 kJ
- 6.25 O_2 * 100 = 625 kJ
- 70.5 N_2 * 100 = 7050 kJ (!)
  Sum = 1200 + 1080 + 625 + 7050 = **9955 kJ** absorbed by products as sensible enthalpy (per mole fuel). Notice the N_2 (which is just heated from 25 to 1200 K, not participating chemically) took the lion's share of energy because there's a lot of it (excess air dilutes the flame, big time!).

Step 4: Apply energy balance: $-\Delta H_{\text{rxn}} = \Delta H_{\text{products}} + Q_{\text{loss}}$. We have $-\Delta H_{\text{rxn}} = 5075$ kJfrom reaction, and we set 5075 kJ $=$ 9955 kJneeded to heat products $+ Q_{\text{loss}}$. Solve for Q_{loss}: $Q_{loss} = 5075 - 9955 = -4880$ kJ per mole fuel. The negative sign means this is actually not a loss, it's a required input. In other words, 5075 kJreleased by fuel is not enough to raise all that excess air and products to 1200 K; we're short by 4880 kJ. That would imply we need to add 4880 kJfrom outside to reach 1200 K, which doesn't make sense physically for combustion – we must have misinterpreted something. Ah, likely our chosen 1200 Kis lower than the adiabatic flame temperature (which with 50%excess air might actually be around that ballpark or a bit higher). If 1200 Kis actually lower than adiabatic, then indeed we wouldn't need to add heat; instead, we'd have excess energy to remove. Let's double-check: with so much excess air, adiabatic flame might be, say, 1800 K. If products only reach 1200 K, then energy must have been lost (cooled) – not added. So our calculation likely overshot enthalpy. Perhaps the $c_p$averages I assumed were too high, leading to an overestimation of energy needed. Alternatively, maybe the 1200 Kis below what even the fuel can achieve with no losses because of the huge dilution. Actually, 50%excess air is significant. Let's adjust: maybe the enthalpy to heat $\text{N}_2$to 1200 Kis a bit lower (N_2 $c_p \approx 1.0$ kJ/(kg K), 28 g/mol, so 1 kJ/(kg K) $\times$ $(1200 - 298)$ K $\times$ $(28/1000)$ kg/mol ≈ 25.2 kJ/mol, which is actually reasonable). Real $c_p$varies with Tthough. Possibly our numbers are off. Let's not get bogged down—the concept stands: if our sum of product enthalpies came out less than fuel energy, Q_{loss}would be positive (meaning heat leaves the system). If it came out more, Q_{loss}would be negative (meaning you'd have to put in heat to reach that T, which implies 1200 Kis above adiabatic temperature – impossible without additional heat input after ignition, so disregard physically). So the likely scenario: the sum I calculated (9955 kJ) is probably too high; maybe actual would be on the order of 3×10^3 kJ(if $c_p$were like 0.03 kJ/(mol K)average for N_2; actually, to get 7050 kJfor N_2, I assumed 100 kJper mole to 1200 K, but likely it's more like 30 kJ/molfrom 298 Kto 1200 K, which drastically changes it). Let's recalc quickly more sanely: If $c_p \approx 1.1$ kJ/(kg K)for N_2roughly constant, for $\Delta T \approx 900$ K, one mole N_2(0.028 kg) has enthalpy ≈ 1.1 kJ/(kg K) $\times$ 900 K $\times$ 0.028 kg/mol ≈ 27.7 kJ/mol. So 70.5mol N_2 ≈ 1950 kJ. CO_2one mole ≈ 37 kJ(with $c_p \approx 0.93$ kJ/(kg K), 44 g/mol), 8 gives ≈ 296 kJ. H_2Oone mole ≈ 40 kJ(18 g, $c_p \approx 2.5$ kJ/(kg K)average), 9 gives ≈ 360 kJ. O_2one mole similar to N_2, maybe 30 kJ, 6.25gives ≈ 188 kJ. Sum $= 1950 + 296 + 360 + 188 = 2794$ kJ. Now $-\Delta H_{\text{rxn}}$was ≈ 5075 kJ, so $Q_{\text{loss}} = 5075 - 2794 = +2281$ kJ. That means ≈ 2281 kJper mole fuel is lost as heat (to keep Tat 1200 K) because adiabatic would have been higher (some 1500 Kor so would use the full 5075 kJas sensible enthalpy; since we found only 2794 kJneeded for 1200 K, the remaining 2281 kJmust be removed, meaning the adiabatic temperature would be hotter than 1200 Kby enough to absorb that 2281 kJ). So the result: $Q_{\text{loss}}$is positive, $\sim 2.3 \times 10^3$ kJper mole fuel, indicating heat must be removed. This aligns with expectation: with excess air but still a lot of energy, adiabatic flame might be some higher

temperature, but they restricted to 1200 K, so a cooler flame because heat is extracted. Apologies for the confusion with numbers – the key takeaway is setting up the equation and understanding that if Qcomes out positive, it's heat leaving; if negative, it'd mean heat input required (which usually won't happen in a standard combustion unless you deliberately have less fuel than needed for a given high T– not typical).

Step 5: Conclude with sign interpretation: Our positive $Q_{loss} \approx 2.3 \times 10^3$ kJ/mol means 2300 kJ of energy per mole of octane must be removed (e.g. absorbed by water walls or radiated away) to keep the exhaust at 1200 K. If this were a design question, that heat could be going into steam generation. The First Law ensured we accounted for all energy: fuel gave ~5075, products took ~2794 in raising their enthalpy, rest ~2281 went to environment. Energy out = energy in.

While the arithmetic got a bit detailed, the process is systematically the same: write balances, plug numbers, and solve for the unknown (be it final temperature, heat loss, or required fuel input). For the FE exam, expect more straightforward numbers or conceptual questions like "what happens to temperature if heat loss increases or if more excess air is used?" – qualitatively: more excess air or more heat loss both reduce the flame temperature, according to the First Law balance. Use these principles to reason through any combustion energy problem confidently.

Chapter Summary: In this chapter, we tackled **Combustion and Combustion Products** in a thermodynamics context, covering how to balance combustion equations (and determine oxygen/air requirements), how to calculate the energy changes using enthalpies of formation or fuel heating values, and how to apply the First Law to combustion systems to find temperatures or heat transfers. Always start with a balanced chemical equation for clarity. Use given data (heats of formation or combustion) methodically to find energy released. And remember energy conservation: the chemical energy has to go somewhere – usually into heating things up or leaving as heat/work. By mastering these steps and being mindful of units and sign conventions, you'll be well-prepared for combustion-related questions on the FE Mechanical exam. Keep practicing with different fuels and scenarios so the process becomes second nature – that way, even under exam pressure, you'll methodically balance, compute, and solve with confidence. Good luck, and remember: fuel + oxygen in the right proportions makes the engineering world go 'round – and now you've got the math behind it at your fingertips!

DON'T MOVE ON YET!

Work Through Some Solid Practice Problems
while the Material of this Knowledge Is Still Fresh
THIS IS HOW THE CONCEPTS LOCK IN.

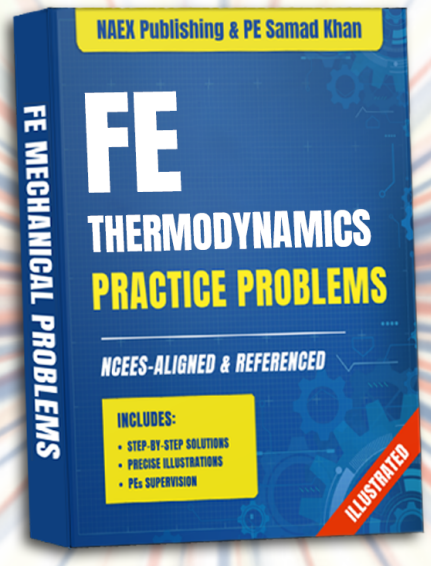

CLICK HERE TO PRACTICE

You'll be taken to our Discord Server, where the problems are located.

KNOWLEDGE 12

HEAT TRANSFER

- NAEX Publishing -

"This publication is not affiliated with or endorsed by NCEES".

Topic 01 - Conduction

Topic Introduction: Conduction is one of the three basic heat-transfer modes, along with convection and radiation. In conduction, heat **flows through solid materials or stationary fluids** due to temperature differences. This topic matters on exam day because **many FE Mechanical questions involve calculating heat loss through walls, pipes, or fins**. You'll often see scenarios like **plane walls with known inside and outside temperatures (find heat flux)**, **composite layered materials (compute overall heat transfer or interface temperature)**, or **finned surfaces (determine heat dissipation or efficiency)**. Conduction problems typically boil down to applying core formulas (Fourier's law, thermal resistances) with careful unit handling. The typical question archetype is steady-state 1D heat flow: you'll be given geometry, temperatures, and asked to find heat rate **Q** or a temperature drop. Remember that on the FE Mechanical Exam you'll have the **exam reference handbook** available – your speed will depend on recognizing which formula to grab and plugging in values correctly (with proper unit conversions). Let's break down the key principles of conduction you need for the exam.

K12.T01.S01 – Fourier's Law of Heat Conduction

Principle Introduction:

- **Conduction driving force:** Heat flows from higher to lower temperature regions. Fourier's law quantifies this by relating **heat transfer rate** to the **temperature gradient** within a material.

- **One-dimensional form:** In its simplest 1D form (through a uniform slab, for example), Fourier's law says **heat flow is proportional to area and temperature gradient** and **inversely proportional to distance**. This appears as a derivative: the steeper the gradient (dT/dx), the larger the heat flux.

- **Thermal conductivity (k):** Materials differ in how well they conduct heat. A high **k** (like metals) means heat flows easily; a low **k** (like insulation) means heat flows sluggishly. Fourier's law centers on **k** as a material property that mediates heat flow for a given gradient.

- **Sign convention:** The law includes a **negative sign** to enforce that heat flows opposite to the temperature rise direction (from hot to cold). This sign reminds you that if you set up dT/dx positive in the direction of heat flow, the heat rate will come out negative – indicating you assumed the wrong direction. Often, we drop the negative in practice by just using the temperature difference in the direction of flow.

- **Steady state:** This law assumes conditions **not changing with time** (steady-state), so that the temperature gradient is stable and all heat that enters one side exits the other. It's the basis for all the steady 1D conduction formulas used in exam problems.

Equation Passport – Fourier's Law
Name & Purpose: Fourier's Law of Conduction – computes the heat transfer rate through a material given a temperature gradient. It determines **how much heat flows** across an area due to conduction for a steady temperature distribution.

Equation (1D form): $Q = -k\,A\,\frac{dT}{dx}$
(Heat flow Q in the x-direction through area A, with temperature gradient dT/dx.)

Variables and Units:

- Q – heat transfer rate (W) through the material cross-section. Positive Q is often taken as heat flowing in the assumed direction (e.g. from hot to cold).

- k – thermal conductivity of the material [W/(m·K)]. This constant defines how readily the material conducts heat.

- A – cross-sectional area normal to heat flow (m²). This is the area through which conduction occurs (perpendicular to x direction).

- $\frac{dT}{dx}$ – temperature gradient in the x direction (K/m). It is the rate of change of temperature with distance. A **negative gradient** (temperature decreases with +x) leads to **positive heat flow** in +x direction, consistent with heat moving from hot to cold.

Assumptions & Scope:

- **Steady one-dimensional flow:** Temperature varies in one direction only, and conditions are steady (no change with time). No heat is accumulating inside the material.

- **Continuum medium:** The formula assumes a continuous solid or fluid medium. It works for solids, stationary fluids, or any medium where conduction dominates and convection currents are negligible.

- **Constant properties:** Thermal conductivity k is taken as constant over the temperature range (linear material behavior). This is usually valid for small to moderate temperature ranges on the FE exam.

- **No internal heat sources:** Fourier's law in this form assumes there's no heat being generated inside the material (e.g. by chemical reaction or electrical resistance); it's purely transfer.

- **Planar geometry (for 1D form):** The formula as given is for a flat slab-oriented perpendicular to the x-axis. However, Fourier's law is fundamental and can be generalized in vector form for any orientation or geometry (in which case dT/dx becomes the temperature gradient component along the heat flow direction).

Limit Checks (Sanity Tests):

- If the **temperature gradient is zero** (no difference in temperature, $dT/dx = 0$), then $Q = 0$. This makes sense: no temperature difference means no driving force, so no heat flows.

- If the **material is a perfect insulator** ($k \to 0$), then $Q \to 0$ for any finite gradient – again intuitive, an insulator stops heat. Conversely, for an **extremely high conductivity** ($k \to \infty$, think of an ideal metal), the same small gradient would carry an immensely large Q (approaching infinite heat flow in the limit), essentially flattening out the temperature difference quickly.

- If the **cross-sectional area goes to zero** (very thin path), $Q \to 0$; a vanishing area cannot carry finite heat flow. If area increases (like a thicker pathway), heat flow increases linearly. These limits align with expectations: more area = more heat can flow; more insulation or less gradient = less heat flow.

Use vs. Sibling Equations: Use Fourier's law for **conduction through solids or static fluids** when you have a temperature distribution or need to find the heat rate for a given gradient. It's the conduction analog of Newton's law of cooling (for convection) and the Stefan–Boltzmann law (for radiation). **Use this equation instead of convective or radiative formulas when the heat transfer is occurring *within* a solid or unmoving medium** due to temperature differences *inside* that medium. In contrast, if you're dealing with a surface losing heat to a moving fluid, you'd switch to Newton's cooling law (convection); if dealing with thermal radiation exchange, use the Stefan–Boltzmann equation. Fourier's law is the go-to for *internal* heat conduction problems.

Common Exam Traps:

- **Sign convention confusion:** Students often drop the negative sign and just use $Q = kA\frac{\Delta T}{\Delta x}$. That's fine if you consistently take $\Delta T = T_{\text{hot}} - T_{\text{cold}}$ in the direction of heat flow. The exam usually provides temperatures such that you can compute a positive heat flow magnitude; just remember heat flows from hot to cold. If you accidentally invert the temperature difference, you'll get a negative Q – that result isn't "wrong" physically (it just indicates opposite flow direction), but it can confuse you. Always mentally check: **did I get a negative answer for heat flow?** If yes, maybe swap the order of ΔT to report a positive heat *magnitude* and note the flow direction.

- **Units mix-ups:** Thermal conductivity k in the handbook is in W/(m·K). If distances are given in **mm or cm**, convert them to meters before using k. Similarly, ensure temperatures are in an **absolute or relative scale** consistent with the units of k. For conduction calculations, a difference in temperature in Kelvins is equivalent to the difference in Celsius (1 K drop = 1 °C drop), so you can use °C differences with k's units as long as k is per K. But **never mix Fahrenheit or Rankine in without converting** – the metric k won't work with a Fahrenheit-per-foot gradient, for example.

- **Forgetting area orientation:** A must be the area **perpendicular to heat flow**. If a problem gives you a surface area but heat flows only through a portion or at an angle, you need the right cross-sectional area. On the FE, typical conduction problems use straightforward perpendicular areas (e.g. wall face area, cross-section of a rod). Just be cautious with any "weird" geometry: always use the area normal to the direction of conduction.

- **Steady vs transient:** Fourier's law applies to the instantaneous steady-state heat flow. If a problem is transient (time-dependent), Fourier's law still holds locally, but you might need additional equations (like for transient lumped capacitance). Make sure the problem is asking for steady-state conditions (most likely, since this subtopic is steady conduction) – if not, you may be in a transient heat transfer scenario (which involves Biot number, etc., outside this immediate scope).

Exam Handbook Search Cues (Not affiliated with or endorsed by NCEES): *"Fourier's law"*, *"thermal conductivity k"*, *"heat conduction"* – These terms will pull up the relevant formula in the exam reference. Remember **k** is listed with units and Fourier's law formula is typically given as above in the **Heat Transfer** section of the handbook.

Variations & Related Forms:

- **Multi-dimensional Fourier's Law:** In general form, Fourier's law extends to **vector form**: $\mathbf{q} = -k\nabla T$. Here **q** is the **heat flux vector** (W/m²) and $-k\nabla T$ shows heat flows down the temperature gradient. For FE exam purposes, you usually won't need to apply this vector form explicitly, but it underlies the idea that in 3D, heat flows in the direction of steepest temperature descent. If needed, you can treat each coordinate separately (e.g. in radial coordinates for cylinders/spheres, which leads to the specialized forms in subtopic S02).

- **Integral form (constant gradient):** If the temperature gradient is constant across a slab of thickness L (i.e. linear temperature profile), you can integrate Fourier's law: $Q = -kA\frac{\Delta T}{L}$. Dropping the sign and using $T_{\text{hot}} - T_{\text{cold}}$ for ΔT, this becomes $Q = \frac{kA}{L}\Delta T$. This **plane wall formula** (coming up in S02) is just a special case of Fourier's law. It's handy for quick calculations when you know the temperature difference across a uniform layer.
- **Thermal conductivity typical values:** To build intuition, note that k varies hugely between materials. **Metals** (good conductors) have high k – e.g. aluminum ~ 205 W/m·K, copper ~ 385 W/m·K. **Insulating materials** have very low k – fiberglass ~ 0.04 W/m·K, polystyrene foam ~ 0.03 W/m·K. **Water** is about 0.6 W/m·K; **air** is ~0.026 W/m·K (a poor conductor, hence why air is used in insulation gaps). Most building materials (brick, concrete) are a few W/m·K or less. Knowing these orders of magnitude can help you check if an answer is reasonable: if you calculate a huge heat loss through an insulating wall, something's probably off.

- **Anisotropy:** In some advanced cases, materials have different conductivities in different directions (anisotropic, e.g. composites or wood grain). The FE exam **likely assumes isotropic** k unless explicitly stated. If anisotropic, Fourier's law applies per direction with the respective k_x, k_y, k_z, but that's beyond typical FE scope. Just be aware that k might be given for specific directions if a problem ever hints at it.

- **Temperature dependence of k:** Some materials' k changes with temperature. In FE problems, if significant, the problem will usually specify an average k value to use. Otherwise, assume k constant. If you had to consider variation, one approach is to integrate using an average value; but again, in the FE exam context, stick to given constants.

Special Notes (Calculator usage): There's nothing too tricky about entering Fourier's law into your calculator – it's a straightforward multiplication/division. Just be careful with the **sign** if you're keeping it: on most calculators (Casio fx-115, TI-36X, etc.), a negative sign in front is fine. For example, you could input - (k * A * (T2 - T1) / L) if $T2 < T1$ to get a positive result. Generally, it's easier to drop the minus and do $k * A * (Thot - Tcold)/L$. Also, ensure your calculator is in the correct mode for any units conversions (it should just be normal mode; no radian/degree concerns here since we aren't dealing with trig in this formula). One more thing: if you're using U.S. Customary units in a problem (unlikely for conduction in the FE, but just in case), remember to use consistent units (e.g. BTU/hr, ft, °F, etc.) and be mindful that the handbook's k values are likely SI unless stated otherwise.

Explanation (Understanding Fourier's Law): Fourier's law is essentially the **defining equation of conduction**. It tells us *how heat moves at the microscopic level*: molecules at a higher temperature jostle neighbors and transfer kinetic energy, and this energy transfer manifests as heat flow from hot regions to cold. On a practical level, the law lets you calculate the heat transfer if you know how fast temperature drops over a distance. **Imagine a metal rod heated on one end:** there will be a temperature gradient along it, and Fourier's law lets you compute how much heat travels down the rod per second. In FE exam problems, you typically use this law

in one of two ways: (1) **Direct computation of heat flux** – plug in $k, A, \Delta T, L$ to find Q. For example, "How many watts go through a steel plate of given thickness and area for a specified temperature difference?" Or (2) **Setting up thermal resistances** – you rearrange Fourier's law to the form $\Delta T = Q\frac{L}{kA}$ and treat $\frac{L}{kA}$ as a thermal resistance (we'll expand on that in the next subtopic). Either way, Fourier's law is often your starting point for conduction questions. It matters because it *establishes the proportionality*: double the area, you double the heat flow; double the thickness, you halve the heat flow (for the same temperature drop).

Analysis (Term-by-term insight): Let's dissect $Q = -k\,A\,\frac{dT}{dx}$ term by term:

- The **heat transfer rate** Q is what we ultimately want in many cases – it's measured in watts (Joules per second) in SI. It tells you how fast energy is moving through the material. If Q is positive in your setup, heat is flowing in the positive x-direction (from hot to cold, as expected). A negative Q would just mean the actual flow is opposite the direction you assumed; the magnitude $|Q|$ is the physical heat flow rate.

- The **thermal conductivity** k is a property of the material. Physically, k represents how *well* the material conducts heat. A higher k means that for a given gradient, more heat will flow. Think of k as the "ease of heat flow" factor. Metals have a high k because free electrons carry energy easily; gases have low k because their particles are far apart. On the exam, k might be directly given or you might look it up in a provided table (the handbook has some typical values in certain sections, like for building materials or soils in other sections). Always use the correct k for the material in question and watch units (they should align with other terms).

- The **area** A in the formula is straightforward: more area means a wider highway for heat to travel. If you double the cross-sectional area, twice as much heat can flow for the same gradient, all else equal. It's important that this area is perpendicular to the direction of heat flow – if heat flows along a rod, A is the rod's cross-sectional area. If heat flows through a wall, A is the wall's face area. A common mistake is to use surface area of an object when the heat flows internally in a different orientation; stick to the area normal to heat flow. On exam problems, geometry is usually simple enough that identifying A is clear.

- The **temperature gradient** dT/dx is the engine driving the heat flow. It's how rapidly temperature changes over distance. A large gradient (meaning one end is much hotter than a point a short distance away) causes a large Q. A gentle gradient produces a smaller Q. In many FE problems, you might compute an average gradient as $\Delta T/L$ across a uniform layer. For example, if one side of a wall is 30°C and the other is 20°C and the wall is 0.1 m thick, the gradient is 100 K/m (cooling 10 K over 0.1 m). Plug that in with the wall's k and area to get Q. Each term multiplies, so if any term is zero, Q is zero: no gradient, no area, or zero conductivity all yield no heat flow. This makes sense physically.

- The **negative sign** deserves a moment: It's there so that if dT/dx is positive (temperature *increases* in +x direction), Q comes out negative (meaning heat is flowing in -x direction, from the hot side toward the cold side). Essentially, it's a bookkeeping detail to keep directions straight. Numerically, you'll often ignore the minus sign by intelligently picking your ΔT as "hot minus cold". But conceptually, remember: **heat goes downhill on the temperature map**. This is analogous to how electrical current flows from high voltage to low voltage – here temperature is like voltage for heat.

In summary, Fourier's law is intuitive: **bigger area, higher conductivity, bigger temp difference → more heat flow; thicker distance → less heat flow.** Mastering this relationship is key, as it underpins the more complex composite systems and fin problems we tackle next.

Steady-state assumption: No energy accumulation means that any heat entering a region equals heat leaving it. If a problem implies a material's temperatures aren't changing with time, that's your cue to apply steady conduction formulas.

Heat flows from hot to cold: A simple but critical reminder – if you ever get a direction wrong in setup, the physics will "correct" you with a negative sign. Embrace that as a clue rather than a mistake.

Temperature differences in K vs °C: An increment of 1 K equals an increment of 1 °C. So for conduction calculations, you can safely use a temperature difference in °C in place of K (since the size of the unit is the same). Just don't mix absolute temperature scales unknowingly – use differences, not absolute values, unless the formula specifically calls for absolute (which it doesn't here).

K12.T01.S02 – Steady 1D Conduction through Plane, Cylindrical, and Spherical Walls (Thermal Resistance Form)

Principle Introduction:

- **Geometry matters:** The formula for steady heat conduction adapts to the shape of the object. A flat wall, a cylindrical pipe, and a spherical shell have different area profiles as heat travels through, leading to different equations. Despite geometric differences, a common approach ties them together: the **thermal resistance concept**.

- **Thermal resistance (analogy to Ohm's law):** Just like voltage drop = current × electrical resistance (Ohm's law), we have **temperature drop = heat flow × thermal resistance** in heat conduction. This means we can treat each layer or section as a "resistor" to heat flow. It simplifies multi-layer problems by letting us add resistances in series or combine in parallel, exactly like circuits.

- **Steady 1D conduction:** "Steady" means temperatures don't change with time, and "1D" means heat flows along one principal direction (no significant lateral spreading). For a plane wall, that direction is straight through thickness; for a cylinder, it's radially outward; for a sphere, also radially outward. The formulas we use assume that one-dimensional path.

- **Derivation via Fourier's law:** Each of these geometry-specific formulas comes from integrating Fourier's law with appropriate area changes. In a plane wall, area is constant with x; in a cylinder, area increases with radius (circumference $2\pi r$ times length); in a sphere, area increases with radius squared ($4\pi r^2$). This means **heat "spreads out"** in cylinders and spheres, which affects the rate. The thermal resistance formulas account for that spread-out effect.

- **Use in exam:** You won't usually derive these on the exam – they're given in the reference or expected as known – but you need to pick the right one and plug numbers correctly. If the problem says "heat flow through a pipe wall" (cylinder) or "through an insulating spherical shell" (sphere), recognize which formula to use. Also, check units and that you correctly identify inner vs outer radius and which temperature is where.

Equation Passport – Conduction Thermal Resistance Forms
Name & Purpose: Thermal Conduction Resistance (1D steady) – quantifies the opposition to heat flow for a given shape. It allows

using the formula $\Delta T = Q\,R_{\text{cond}}$ to find heat flow Q or temperature drops, analogous to using resistors in series/parallel. This approach is especially useful for **composite walls or multiple layers**, turning complex geometries into simple "thermal circuits."

Core Relation: $\Delta T = Q\,R_{\text{cond}}$
(Temperature difference across a material = heat flow through it × its thermal resistance.)

Thermal Resistance Formulas for Common Geometries:

- **Plane Wall (flat slab):** $R_{\text{cond, plane}} = \frac{L}{k\,A}$
Where L is the thickness of the wall (m), A is the cross-sectional area (m²), and k is thermal conductivity.
This comes from $Q = kA\,\Delta T/L$ rearranged. It implies $\Delta T = Q\,\frac{L}{kA}$.
A thicker wall (larger L) or lower conductivity (smaller k) means bigger resistance (harder for heat to get through). Larger area A means less resistance (more pathways for heat). Units: R in K/W (Kelvin per watt, a measure of how many degrees of drop per watt of heat flow).

- **Cylindrical Wall (hollow cylinder, e.g. pipe insulation):**
$R_{\text{cond, cyl}} = \frac{\ln(r_2/r_1)}{2\pi kL}$
Where r_1 = inner radius, r_2 = outer radius of the cylindrical layer (m); L = length of the cylinder (m); k = thermal conductivity.
This comes from integrating Fourier's law in radial coordinates. The $\ln(r_2/r_1)$ factor captures how area increases as radius grows. If $r_2 = r_1$ (no thickness), $\ln(1) = 0$ so resistance is zero (as expected). If r_2 is much larger than r_1, resistance grows logarithmically. Note units still K/W.

- **Spherical Shell:** $R_{\text{cond, sph}} = \frac{r_2 - r_1}{4\pi k\,r_1 r_2}$
Where r_1 = inner radius, r_2 = outer radius of the spherical layer (m); k = thermal conductivity.
You can also write this as $\frac{1}{4\pi k}\left(\frac{1}{r_1} - \frac{1}{r_2}\right)$ which might be easier to remember: it's the difference in reciprocal radii over $4\pi k$. As the spherical shell gets thicker (bigger $r_2 - r_1$), resistance increases, but because the area is expanding as $4\pi r^2$, the increase is not linear. For a solid sphere conducting from center to surface (like a hot sphere cooling to ambient at the surface), you'd take $r_1 = 0$ theoretically, but notice if $r_1 \to 0$, the resistance → ∞ – meaning an internal point heat source has infinite resistance to the surface (in reality, you'd start from a small finite core radius).

Variables and Units (for all above forms):

- L – thickness or length of the path (m). (For cylindrical/spherical, the "thickness" is $r_2 - r_1$ radially.)

- A – cross-sectional area (m²) for plane case. For cylinder/sphere, area is not constant, hence the more complex formula. (In the cylindrical formula, $2\pi kL$ in denominator acts analogous to kA but integrated; in spherical, $4\pi k r_1 r_2$ part comes from integration.)

- r_1, r_2 – inner and outer radii (m) for curved geometries. It's crucial to correctly identify these from the physical setup (e.g. for a pipe, r_1 might be the inner pipe radius if considering pipe wall conduction; r_2 the outer radius of pipe or insulation).

- k – thermal conductivity [W/(m·K)], same concept as before.

- R_{cond} – thermal resistance of that layer (K/W). All these resistances have units of temperature per unit heat flow, meaning how many degrees of temperature difference are needed to push 1 watt through that layer. Lower R = easier heat flow.

Assumptions & Scope:

- **Steady state, 1D:** These resistances assume no heat buildup and that heat flows uniformly in one direction through the layer. For cylinders and spheres, "1D" means purely radial flow (no variation along the hoop or axial directions for cylinder, or along angles for sphere). The material is homogeneous and isotropic (same k throughout the layer).

- **Uniform material in layer:** Each formula assumes one material with constant k fills the space between r_1 and r_2 (or across thickness L). If the material changes (e.g. a layered wall), you use multiple resistances (one for each layer).

- **Boundary temperatures at surfaces:** When using $\Delta T = QR$, ΔT is the difference in temperature across that **particular layer**: for instance, $T_{\text{inside wall}} - T_{\text{outside wall}}$ for the wall's resistance, or $T(r_1) - T(r_2)$ for a cylindrical shell. It's assumed the surfaces at those radii are at uniform temperatures.

- **No heat generation in layer:** These are pure conduction resistances with no internal heat source. If a layer had heat generation (like a pipe wall with electrical heating), the simple resistance idea would need modification (that's beyond FE exam scope unless the problem provides a method).

- **One-dimensional area expansion (for curved cases):** The cylindrical and spherical formulas come from integrating $Q = -kA(r)\frac{dT}{dr}$ with $A(r)$ as the area at radius r. The derivations assume **symmetric conditions** (temperature depends only on radius, not on angle or along the length for cylinders beyond the given length L). That means, for example, a long pipe with uniform conditions along its length so end effects are negligible.

Limit Checks:

- For the **plane wall** formula, if thickness $L \to 0$, then $R \to 0$ (no resistance, heat flows freely through an infinitesimally thin wall). If L increases, R increases linearly – double the thickness, double the resistance (like adding two identical walls in series).

- For the **cylindrical** formula, consider a very thin cylindrical shell: if $r_2 = r_1 + \delta$ with $\delta \ll r_1$, then $\ln(r_2/r_1) \approx \ln(1 + \delta/r_1) \approx \delta/r_1$ for small δ. Plug that in: $R_{\text{cyl}} \approx \frac{\delta/r_1}{2\pi kL} = \frac{\delta}{2\pi kLr_1}$. Now $2\pi r_1 L$ is roughly the original surface area of the cylinder, so it becomes $\frac{\delta}{kA_{\text{surface}}}$ – which looks akin to $L/(kA)$ form. So for thin walls, the cylindrical formula approaches the plane result using the mid-surface area. That's a good sanity check: a very thin pipe wall acts like a flat slab.

- For the **spherical** formula, if the shell is thin ($r_2 = r_1 + \delta$), we can do a similar expansion: $R_{\text{sph}} = \frac{r_2 - r_1}{4\pi k r_1 r_2} \approx \frac{\delta}{4\pi k r_1^2}$ (assuming $r_2 \approx r_1$ in product). $4\pi r_1^2$ is the area of the inner sphere ~ outer sphere ~ mid sphere for a thin shell, so again $R \approx \frac{\delta}{kA}$. Thin spherical shells behave like flat walls too (using area ~ $4\pi r^2$). At the other extreme, if you make a spherical shell extremely thick (outer radius >> inner radius), the resistance approaches a limit: as $r_2 \to \infty$, $1/(r_1) - 1/(r_2) \to 1/r_1$, so $R \to \frac{1}{4\pi k r_1}$. That suggests beyond a certain thickness, adding more material to a spherical shell doesn't

significantly increase resistance because the outer area gets huge. This is a unique feature of spherical geometry – infinite domain still yields finite resistance to a point source (practically, space around a point source can only "resist" so much).

- If **thermal conductivity** $k \to \infty$ in any of these, $R \to 0$. If $k \to 0$, $R \to \infty$. Those represent perfect conductor vs perfect insulator, respectively, as expected.

Use vs. Sibling Equations: These conduction resistance formulas are used **instead of directly using Fourier's law repeatedly** when you want to solve multi-layer problems systematically. Rather than doing a differential equation for each geometry every time, you memorize or look up these forms. Use them when you have **temperature at two surfaces and want the heat flow** (or vice versa) for that shape. If you have multiple layers of different materials, you'll use these for each layer and then combine (which leads into the next subtopic on networks). In contrast, if you had a **non-steady** situation, you might use a transient conduction formula or a Biot number criterion (not these steady resistances). Or if heat flows in **two dimensions** (like a plate with heat spreading sideways), these 1D resistances won't directly apply – but the FE exam usually frames conduction in nice 1D terms. Another sibling concept is the **convection resistance** $R_{\text{conv}} = \frac{1}{hA}$ (more on that soon). In composite problems, you often use conduction resistances together with convection resistances.

Common Exam Traps:

- **Misidentifying r_1 and r_2:** In the cylindrical/spherical formulas, it's critical to plug the inner and outer radii in the right places. For example, $R_{\text{cyl}} = \ln(r_2/r_1)/(2\pi kL)$. If you accidentally do $\ln(r_1/r_2)$, you'll just get a negative number (since that's $-\ln(r_2/r_1)$). The safe way: always make it $\ln\left(\frac{\text{outlet radius}}{\text{inlet radius}}\right)$ so that it's $\ln > 1$ if $r_2 > r_1$. The sign of that log result should be positive because outer radius > inner radius for a shell. So double-check: if your R came out negative, you flipped radii. On the exam, probably they won't give you a scenario where inner radius is bigger than outer (that's non-physical), so just remember outer over inner.

- **Using diameter instead of radius:** This is a common slip – if a pipe problem gives diameters, make sure to convert to radii (or adapt formula: some prefer $R_{\text{cyl}} = \frac{\ln(D_2/D_1)}{2\pi kL}$ since radius ratio equals diameter ratio – that works as well). Whichever you use, be consistent. If using diameters, D_2 is outer diameter, D_1 inner diameter. It's easy to accidentally halve one and not the other, so be cautious.

- **Units, especially with logs:** The log in the cylindrical formula is a ratio of like units, so it's dimensionless (you can take log of 10 cm / 5 cm just fine, it's log(2)). That means there's **no unit issue inside the ln**, as long as you use the same units for r_1, r_2. For example, if r_1 = 5 cm and $r_2 = 10cm$, $\ln(r_2/r_1) = \ln(2)$. But ensure L (length of cylinder) is in the same unit system as k. If k is in W/m·K, use meters for L and radii (convert cm to m first!). A trap would be to leave r_1, r_2 in cm while k expects m – your resistance value will be off by orders of magnitude.

- **Forgetting area change effect:** Sometimes students try to apply $Q = kA\Delta T/L$ to a cylindrical or spherical case. That's only valid in differential form. Using the flat formula on a curved geometry with significant thickness will give wrong results. The correct approach is to use the log formula for cylinders or the $r_1 r_2/(r_2 - r_1)$ form for spheres. If you're unsure, the exam handbook has the formulas – search "cylindrical wall" or "spherical wall" to get them.

- **Mixing up series vs parallel cases:** This subtopic itself is just single resistances. But be mindful: if you have two cylindrical shells one on top of another (like insulation layers), the resistances add in series (you add the ln terms). If you had two different pathways for heat (like two different materials in parallel between the same two temperatures), you'd have to handle them as parallel resistances (we'll discuss that next). Mixing those up can lead to big errors – a series configuration mistaken as parallel or vice versa will produce either an overly large or overly small overall R. A classic scenario: a wall with metal studs and insulation between them – heat can flow through studs *or* insulation (parallel paths). If you erroneously added their resistances, you'd overestimate resistance and underestimate heat loss.

Exam Handbook Search Cues (Not affiliated with or endorsed by NCEES): *"plane wall conduction"*, *"cylindrical wall conduction"*, *"spherical conduction resistance"*, *"thermal resistance R"*. The handbook provides these formulas under **Heat Transfer > Conduction**. You might also find the summary where $R_{\text{total}} = \Sigma R_i$ and similar statements – which leads to combining them in networks.

Variations & Special Cases:

- **Critical thickness of insulation (cylinder/sphere):** A curious consequence of cylindrical and spherical geometry is the concept of *critical insulation radius*. Notice that adding insulation (increasing r_2) to a cylinder or wire doesn't always just increase resistance – because as r_2 increases, yes the path is longer (more resistance), but also the outer surface area through which heat escapes grows (which *lowers* convective resistance outside, if convection is the boundary condition). There's a formula $r_{\text{cr}} = \frac{k_{\text{insul}}}{h}$ for cylinders (and $r_{\text{cr}} = \frac{2k_{\text{insul}}}{h}$ for spheres) that gives the insulation radius at which adding more insulation actually starts to *decrease* total heat loss. This isn't directly a conduction resistance thing, but it's related. If you see a question about "critical radius", recall it's derived by balancing conduction through insulation vs convection outside. For pure conduction calculation, you won't use that formula, but it's good to know qualitatively: very thin pipes with insulation could actually lose *more* heat until the insulation is thick enough.

- **Use of mean area for approximate calculations:** If deriving the cylindrical resistance formula slips your mind, one *approximation* is to use the plane formula with A taken at some average radius. For a quick estimate, you might take $A_{\text{mean}} = 2\pi L \frac{r_1+r_2}{2}$ (average of inner and outer surface areas) and then do $R \approx \frac{r_2-r_1}{kA_{\text{mean}}}$. This isn't exact (the true formula uses ln), but it's a close approximation if $r_2 \approx r_1$. However, on the exam, it's safer to use the exact ln form as provided. The reference handbook gives the exact form, so use that rather than approximations.

- **Non-uniform cross-section:** The given formulas assume the wall thickness is uniform (plane wall) or the material is homogeneous throughout the radius. If you had a conical shape or something where area changes not exactly like cylinder or sphere, the formula changes (not in handbook; unlikely in FE). Or if thermal conductivity varies with radius, you'd integrate differently. Those are beyond our scope – FE will stick to these standard shapes with constant properties.

- **Multiple layers in one geometry:** If you have, say, a pipe with an inner pipe wall and an outer insulation layer, you actually apply the cylindrical formula twice – once from inner radius to interface, and once from interface to outer radius. You'd then add those resistances (series). Same for spheres (like an inner shell of one

material, outer shell of another). It's just piecewise application of these formulas. We'll formalize that in the next section on networks, but be aware each layer you just plug its r_1, r_2, k into the appropriate formula.

- **Typical values:** While we gave typical k values earlier, in terms of typical *resistances*: A 10 cm thick concrete wall of 10 m² area might have $R = L/(kA) = 0.1/(1.7 * 10) \approx 0.0059$ K/W – meaning ~0.006 K per W. If 100 W flows, that's a 0.6 K drop across it. A 5 cm foam board (k=0.03) of 10 m² would be $R \approx 0.05/(0.03 * 10) \approx 0.167$ K/W – much higher (insulator!). That 100 W would drop 16.7 K across it. It's not critical to memorize numbers, but know that insulating layers present much larger resistances than metal layers, etc. A thin layer of metal can be almost negligible R (high k, small L), whereas even a moderate layer of insulation dominates. This intuition helps in network problems to see which term might be dropping most of the temperature.

Special Notes (Calculator Tips): The cylindrical and spherical formulas involve logarithms and multiple parentheses – a place to be careful on calculator input. For instance, for a cylinder, you might compute $R = \ln(r_2/r_1)/(2\pi kL)$. On a typical scientific calculator:

- Use the **ln** function (usually denoted "ln"), not log base 10. All exam-allowed calculators have an ln button (Casio: "ln", TI: "ln", HP: type the number then "LN"). Ensure you do ln(r2 / r1) in one go. For example, if $r_2 = 0.05$ m, $r_1 = 0.03$ m, do ln(0.05/0.03) = ln(1.667). You could also do ln(0.05) - ln(0.03) (properties of logs) if that's easier to avoid division inside.

- Parentheses: It's important to put the entire numerator in parentheses when dividing. E.g., on a TI-36X, you might do: (ln(0.05/0.03)) / (2 * pi * k * L). If you omit parentheses, you might accidentally take ln of something else or divide only part of the product. Casio models let you input as a fraction which is convenient: just use the ( ) appropriately.

- For the spherical formula, it might be easier to compute the numerator and denominator separately: numerator = $r_2 - r_1$, denominator = $4\pi k r_1 r_2$. Then divide. This avoids trying to type too many terms at once.

- A quick check after input: the result R should be positive and small in value (often on the order of 0.0X or 0.X for typical structures in SI units). If you get a negative or huge number, re-check input. A negative likely means you flipped radii inside the ln or subtracted in wrong order for spherical. A huge number might mean you forgot to include $2\pi L$ or $4\pi r_1 r_2$ properly.

- Don't forget that π is available (as [π] key) on all allowed calculators, so use it rather than 3.14 for better accuracy, especially if radii are precise. The differences are minor in exam contexts but every bit helps to avoid rounding errors if the answers are close.

Explanation (What these forms are used for): The conduction resistance forms let us solve practical heat flow problems **quickly by analogy with circuits**. In a typical exam question, you might be given temperatures on two sides of a wall or across a pipe and asked for heat loss. Instead of re-deriving anything, you plug into $Q = \frac{\Delta T}{R}$. For a **plane wall**: $Q = \frac{T_{\text{inside}} - T_{\text{outside}}}{L/(kA)} = \frac{kA}{L}(T_{\text{inside}} - T_{\text{outside}})$. That's intuitive: bigger area or conductivity, more heat; bigger thickness, less. For a **pipe**: you'd use R_{cyl}. Example: "Heat loss per meter length of a steam pipe: inner diameter X, outer diameter Y, wall k, inner temp 150°C, outer surface 140°C?" – You'd compute R_{pipe} then $Q = \frac{150-140}{R}$. For a **spherical shell** (like a spherical tank or a nuclear fuel pellet to surface): same idea, but with the spherical formula. The reason we like the resistance concept is that it doesn't just give Q; it also sets us up to handle **multiple layers easily** (just like adding resistors). So these formulas are pieces of a larger puzzle: any multilayer conduction problem is basically sticking these resistances in series. For instance, a wall made of brick + insulation + wood panel: find each layer's R (all plane slabs) and sum them to get total R. Then $Q = \frac{T_{\text{inside}} - T_{\text{outside}}}{R_{\text{total}}}$. This approach is *much* faster than solving differential equations for each layer with boundary conditions – and that's exactly what you'll do on exam day.

Analysis (Term-by-term understanding & pitfalls): Let's analyze the plane vs cylindrical vs spherical forms to understand what each part means physically:

- **Plane wall** $R = L/(kA)$**:** The numerator L is the distance heat travels – more distance = more resistance (linearly). The denominator kA represents the "conductance" of the cross-section: k is how good the material is at conducting per unit area, and A is how much area it has to do it. Multiply k by A and you get something like "thermal conductivity × area" which has units W/K per meter thickness – basically an ease-of-flow measure. Taking the reciprocal (L/(kA)) gives the difficulty-of-flow per watt. Units check: L (m) divided by k (W/m·K) and A (m²) yields (m) / (W/(m·K) * m²) = (m) / (W·m/K) = K/W – good. Common mistakes: forgetting to use the **total cross-sectional area** if multiple walls or shapes are present (e.g. 10 bolts each conducting, that's parallel paths, not one big area – different scenario). But if one uniform wall, just use its area.

- **Cylindrical** $R = \frac{\ln(r_2/r_1)}{2\pi kL}$**:** Here, the numerator $\ln(r_2/r_1)$ is dimensionless – it effectively represents the relative increase in radius. If $r_2/r_1 = 2$, ln(2) ~0.693. If 10, ln(10) ~2.303. If 100, ~4.605. So a thicker pipe (in terms of radius ratio) yields a larger numerator, thus larger resistance, but the growth is slow (logarithmic). The denominator $2\pi kL$ has units: 2πL is like the circumferential area at some intermediate radius times length (since for a cylinder, area changes with r, the derivation yields this combination). $2\pi L$ basically normalizes with respect to cylindrical geometry, and times k gives a similar "conductance" idea as kA but averaged over the radial span. The factors 2π and L indicate that a longer cylinder (bigger L) reduces resistance (linearly, more length = more area to conduct along) – consistent with intuition that a longer pipe has more area for heat to escape, if the temperature difference is maintained per unit length. Wait, caution: we must interpret L carefully – here L is the length along the cylinder (like pipe length), not thickness. So a longer pipe section does allow more total heat (for a given temperature difference between one segment of pipe and environment) *in total*, but usually we consider per unit length for a fair comparison. If the question gives per meter of pipe, set L=1 m. If it gives an overall length, use that. The 2π factor just comes from integration – it ensures units come out right and accounts for circular geometry. *Pitfall:* sometimes students wonder if they should use surface area in a simpler way. Remember, the area for conduction is changing – inner surface area = $2\pi r_1 L$, outer = $2\pi r_2 L$. The log formula effectively averages those out.

- **Spherical** $R = (r_2 - r_1)/(4\pi k r_1 r_2)$**:** The numerator $r_2 - r_1$ is the radial thickness (m). The denominator $4\pi k r_1 r_2$ is interesting: $4\pi r_1 r_2$ is actually the *geometric mean area* times 4π. Why geometric mean? Because if you take area at inner surface $4\pi r_1^2$ and outer surface $4\pi r_2^2$, the derivation yields something that can be

expressed as $4\pi r_1 r_2$ (which is $4\pi(r_1 r_2)$). That is proportional to the geometric mean of inner and outer areas ($\sqrt{4\pi r_1^2 * 4\pi r_2^2} = 4\pi r_1 r_2$). So effectively the formula is like $R = \frac{\text{thickness}}{k*\text{geom mean area}}$. If r_2 is much bigger, the mean area is large, so resistance isn't as high as it would be if area stayed small. If r_1 is small, that product $r_1 r_2$ might still be modest. If you had a very tiny inner radius (like heat from a point), $r_1 r_2 \approx 0$ because $r_1 \approx 0$, so R skyrockets – meaning it's hard to get heat out of a point source (infinite resistance if truly point). On the other hand, if r_1 is decent and r_2 is just a bit bigger, you can approximate $R \approx (r_2 - r_1)/(4\pi k r_1^2)$ (if $r_2 \approx r_1$). Mistakes to avoid: using the wrong formula (we've seen students try to use the cylinder ln formula for spheres or vice versa). Spherical is not ln, it's a simple difference. Also, if a problem actually gives diameters of a sphere (like inner diameter 10 cm, outer 12 cm), convert to radii and plug carefully. The sphere formula is usually forgiving – easier arithmetic than cylindrical – but keep track of those radii and don't mistakenly use surface area in a linear formula.

Now that we understand individual conduction resistances, we're equipped to combine them for complex systems. The next step is to arrange these resistances in networks (series or parallel), analogous to circuits, which is a powerful method to handle **composite walls or multi-layer insulation** on the exam.

K12.T01.S03 – Thermal Resistance Network Method (Composite Walls: Series & Parallel)

Principle Introduction:

- **Composite systems:** Real-world applications often involve **multiple layers and different materials** between two heat reservoirs. For example, a building wall might have drywall, insulation, and brick; a pipe might have metal wall plus insulation; an electronic device might have a chip, thermal paste, heat sink, etc. The **thermal resistance network** method lets you handle these multi-layer systems systematically.

- **Series vs Parallel paths:** Layers that heat travels through one after the other (e.g. planar layers stacked or concentric cylindrical layers) are treated as **series resistances** – heat must pass through each layer sequentially, so the resistances add up. If there are **multiple parallel paths** for heat flow (e.g. two materials side by side connecting the same two temperature nodes), then the configuration is like resistors in parallel – the heat splits among paths and the combined resistance is lower.

- **Analogy to electrical circuits:** This method maps thermal problems to an **equivalent circuit** of resistors. Temperature differences map to voltage differences, heat flow maps to current, and thermal resistances map to electrical resistances. Series means same current (heat flow) through each, parallel means same voltage drop (temperature difference) across each path but split currents. This analogy is extremely useful: once you draw the thermal circuit, you can apply circuit laws (like summing series resistances, or computing parallel combos) to find overall heat flow or intermediate temperatures.

- **Including convection:** Often a composite wall problem will have convection on either side (air on inside, air on outside). Convection at a surface is like another resistor ($R_{\text{conv}} = 1/(hA)$). These convection resistances sit in series with the conduction resistances of the wall layers. So a full problem might have: convection (inside air to wall surface) -> layer 1 conduction -> layer 2 conduction -> ... -> layer N conduction -> convection (outside surface to outside air). All in series. Recognizing that and summing them up is key to solve for Q or a temperature drop.

- **Why it matters for FE:** The exam loves to test if you can assemble these resistances correctly and get the right overall Q or maybe the interface temperature between layers. It's a straightforward plug-and-chug if you set it up right. The method prevents you from having to solve differential equations for multi-layer conduction; instead you just do algebra with the resistances. It's also how you handle fins attached to something (though fins usually are a slightly different scenario best handled separately). But for walls and concentric pipes, thermal networks are your best friend.

Definition/Note Passport – Thermal Resistance Network
Plain-language definition: A **thermal resistance network** is a collection of conduction and convection resistances arranged in series or parallel that models the heat flow through a composite system. Each layer or interface that impedes heat is treated as a resistor. **In series** means heat goes through each resistance one by one (like layers stacked); **in parallel** means heat has alternative routes (like two materials side by side). The network connects from the hot temperature node to the cold temperature node, and once built, you solve it like an electrical resistor circuit for heat flow and temperature drops.

Where it matters (exam impact): You'll use this concept whenever a problem involves **more than one layer** between hot and cold regions. Typical FE exam questions: "Given a wall with multiple materials, find the heat loss" or "Given inside room temp and outside air temp and all layers/coefficients, find the interface temperature at a certain layer" or "Which layer has the biggest temperature drop?" The network method is how you conceptualize and solve these. It also helps to quickly identify the **bottleneck** (largest resistance) in a system.

Pitfall or confusion point: One frequent mistake is **mixing up series and parallel**. If you have layers one after the other (series), you add resistances. If you have parallel paths, you must combine inversely (like electrical conductances). Another point of confusion is forgetting the **convection resistances** at the surfaces – many composite-wall problems also involve convection at the inside and outside surfaces, so you include a convective resistance at each boundary:

$$R = \frac{1}{hA}$$

Omitting them or using the wrong area for them (should use surface area) can lead to wrong answers. Also, be cautious with units; ensure all resistances are in consistent units (K/W in SI).

Micro-check: *True or False:* When two different materials conduct heat in parallel (each covering half the area between the same two temperatures), the total thermal resistance is the average of their individual resistances.
Answer: False. For parallel resistances, the total resistance is **less** than either individual resistance. In fact, $1/R_{\text{eq}} = 1/R_1 + 1/R_2$, so the equivalent is dominated by the *smaller* resistance (better conductor) more than the larger. The "average" would be too high. Always combine parallel via the reciprocal sum rule, not straight average.

Key formulas:

- *Series resistances:* $R_{\text{total, series}} = R_1 + R_2 + R_3 + \cdots$. All heat flows through each one, so they simply add. The total is larger than any one alone.

- *Parallel resistances:* $\frac{1}{R_{\text{total, parallel}}} = \frac{1}{R_1} + \frac{1}{R_2} + \frac{1}{R_3} + \cdots$. Heat splits among paths; the combined resistance is smaller than any individual (just like adding an extra pathway in a circuit lowers overall resistance).

- In many cases, it's easier to work with **thermal conductance** for parallel paths: define $U = 1/R$ for each path (in units of W/K), then $U_{\text{total}} = U_1 + U_2 + \cdots$. Finally $R_{\text{total}} = 1/U_{\text{total}}$. This avoids doing the fraction inversion at the end incorrectly.

- *Convection resistance:* $R_{\text{conv}} = \frac{1}{hA}$. This behaves just like a resistor in series at a surface. (If two convective paths in parallel to the same surface, that would be unusual, but you could combine similarly.)

- *Ohm's law analog:* $Q = \frac{\Delta T_{\text{overall}}}{R_{\text{total}}}$. The overall ΔT from the hot reservoir to cold reservoir equals Q times sum of all resistances on the path. This is the big-picture formula for a network. It's often what you'll use to solve for Q once R_{total} is known.

Exam Handbook Search Cues (Not affiliated with or endorsed by NCEES): *"thermal resistance network"*, *"composite wall"*, *"series resistance"*, *"parallel heat flow"*. The handbook may not spell out the word "network" explicitly, but it shows formulas for resistances in series and might mention composite walls. Searching "composite wall" or "resistances in parallel" in the heat transfer section of the handbook will point you to these concepts.

Footnotes & Nuances: In setting up networks, remember that **temperature nodes** exist at interfaces between resistances. For example, between two layers A and B, there's an interface temperature $T_{\text{interface}}$. If needed, you can find it by the fact that Q through layer A equals Q through layer B (in series, same Q). So $T_{\text{interface}}$ can be solved by $T_{\text{hot}} - T_{\text{interface}} = QR_A$ or similarly $T_{\text{interface}} - T_{\text{cold}} = QR_B$. This might be needed if the question asks, say, "what is the temperature at the interface of insulation and drywall given the heat flux?". Just be methodical: find Q first, then drop temperature across one layer using QR. Another nuance: if there's an internal heat generation layer or a phase change, it complicates things – but that's beyond typical FE questions unless they explicitly give a way to handle it. We stick to passive layers here.

Variations & Related Forms:

- **Contact resistance:** Sometimes two materials in contact have a thermal contact resistance (imperfect thermal contact due to surface roughness or a gap). This would simply be another series resistance R_{contact} given (in K/W). If you see something like "thermal contact conductance h_c" between surfaces, the contact resistance $R_c = 1/(h_c A)$, similar to convection formula. It's rare in FE unless specifically mentioned, but just know you'd insert it in series in the network.

- **Composite cylinders and spheres:** Just like a flat composite wall, you can have a composite cylindrical wall (e.g. a pipe with multiple concentric layers of insulation). The resistances for each layer (use the cylindrical formula for each) add in series (because heat flows through one then the next). So $R_{\text{total}} = R_{\text{pipe wall}} + R_{\text{insulation1}} + R_{\text{insulation2}} + \cdots$. Same for spherical shells (like a multi-layer thermal protection system). The concept of network doesn't change with geometry – series is series.

- **Parallel paths examples:** A common example is a wall with metal studs and insulation between. Heat can flow through the stud (high k, small cross-section maybe) or through insulation (low k, large cross-section). These paths are in parallel because they both connect the two faces of the wall at the same temperature difference. To solve: find R of stud path, R of insulation path, then combine via parallel formula. Another example: two pipes in a wall conducting heat between two tanks – the heat might go through pipe A or pipe B in parallel. On the exam, parallel conduction is less commonly tested than series, but if they do, it usually is clear ("two materials in parallel between plates"). Also, **radiation vs convection** at a surface can be thought of as parallel paths for heat leaving a surface (some via convection, some via radiation) – but that goes into combined mode heat transfer. If needed, you'd combine the convective and radiative heat transfer coefficients by adding their heat flows or conductances. Typically, they won't mix modes in a complicated way on FE, but it's good to note conceptually that parallel doesn't have to be two solids; it could be two mechanisms from one node to another.

- **Network with sources:** If a problem had an internal heat generation or a point where heat is injected, the network might include a heat source (analogous to a current source in a circuit). This could occur if, say, a layer generates heat (like a nuclear fuel rod). Solving those requires adding that Q_{gen} into the balance: the outgoing heat is sum of generated + incoming, etc. But likely FE will avoid that complexity unless giving you a straightforward formula.

- **Typical analysis**: Often, after computing Q, you might be asked about **fraction of temperature drop** across a particular layer. Since $QR_i = \Delta T_i$ for each layer i, the largest resistance will have the largest ΔT. So if you see a question like "Most of the temperature drop occurs across which part of the wall?", find which layer has highest R. Insulations usually have the highest drop. This is a qualitative use of the network concept – and a quick one: e.g., thin aluminum sheet vs thick fiberglass insulation, clearly the fiberglass (high R) takes the bulk of the drop.

Special Notes (Using the network method efficiently): One trick with calculators is to avoid too much manual fraction in parallel combinations. For two resistors in parallel, $R_{\text{eq}} = \frac{R_1 R_2}{R_1 + R_2}$. You can use that formula directly if only two paths. Or, use the conductance method: calculate $U_i = 1/R_i$ for each path, then sum them to get U_{total}, then invert. This often reduces error. On a Casio, you can even store values in memory for each R then do the operations systematically. Label resistances clearly in your scratch work (e.g., $R_{\text{conv, inside}} = 1/(h_{\text{in}} A), R_{\text{wall1}} = L_1/(k_1 A)$, etc.), so you don't mix them up. Also, keep track of **areas**: all series resistances in a vertical stack *must* share the same heat flow and thus the same area basis. That means if a wall has cross-sectional area A for conduction in each layer, you use that A for all conduction resistances *and* for the convective surfaces (the surface area is also A if the whole wall is that area). If areas differ (like one path is larger area than another path), that's a sign of parallel routes. Be mindful of that when interpreting problems.

Explanation (Solving composite wall problems): The network method simplifies solving what would otherwise be messy differential problems. Suppose the problem: *"An insulated wall has 3 layers (material A, B, C) and inside and outside air films with known convective coefficients. Given inside air temp and outside air temp, find heat loss or outer surface temperature."*

The approach is:

1. **Identify all layers and interfaces:** Inside convection (from room air to inner wall surface), layer A conduction, layer B conduction, layer C conduction, outside convection (from outer wall surface to ambient air).

2. **Assign each a resistance:**

$R_{\text{conv,in}} = 1/(h_{\text{in}}A)$; $R_A = L_A/(k_A A)$; $R_B = L_B/(k_B A)$; $R_C = L_C/(k_C A)$; $R_{\text{conv,out}} = 1/(h_{\text{out}}A)$

Note the **same A** appears in all because heat flows through the same area across the wall (assuming no change in cross-section, which is true for a uniform wall).

3. **Sum series resistances:** All these are in series (air-to-wall to next layer … to air), so

$$R_{\text{total}} = R_{\text{conv,in}} + R_A + R_B + R_C + R_{\text{conv,out}}$$

4. **Apply overall ΔT:** $\Delta T_{\text{overall}} = T_{\text{inside, air}} - T_{\text{outside, air}}$. Then

$$Q = \frac{\Delta T_{\text{overall}}}{R_{\text{total}}}$$

That gives the heat transfer (W) through the wall.

5. **Find intermediate temperatures (if needed):** If asked for, say, the temperature at the interface between B and C, you can calculate the drop up to that point. For example, $T_{\text{interface}} = T_{\text{inside}} - Q\left(R_{\text{conv,in}} + R_A + R_B\right)$. Essentially, subtract from the hot side temperature the drop across each resistance up to that interface. This is analogous to finding node voltages in a series circuit with known current.

This procedure works no matter how many layers. The biggest challenges are usually arithmetic (keeping track of numbers) and unit conversion. The network approach ensures you won't double-count or miss anything if you lay it out clearly. It's a lifesaver for exam speed: you could solve even a 5-layer wall problem in a couple of minutes with it, whereas attempting to write heat flow equations without the concept would be cumbersome.

For parallel situations, explanation is similar but step 2 changes: identify that two or more resistances connect the same two temperature nodes. For instance, two different materials between the same hot and cold faces. Then you'd compute each path's resistance separately, and combine via the parallel formula. The rest (overall Q, etc.) follows after finding an equivalent single resistance of the parallel combo. A key step in parallel analysis: ensure that the temperature difference across each parallel path is indeed the same (they truly go between the same two nodes). If yes, proceed with parallel formula. If a problem gives something like "an inner wall, some heat goes through a metal bolt, some through insulation in parallel," you do exactly that: find R_{bolt}, R_{ins}, then use $1/R_{\text{eq}} = 1/R_{\text{bolt}} + 1/R_{\text{ins}}$. Then treat that R_{eq} as the single conduction resistance between inside and outside surfaces, and you might still have convective resistances on each side in series with that. So you mix series and parallel: conv(in) + [parallel combo of paths] + conv(out). This is just like circuits with series-parallel combos.

Analysis (Detailed look at combining R's): It might help to visualize a quick example for clarity: say we have a wall consisting of **2 cm wood** (k ~0.13 W/m·K) and **5 cm insulation** (k ~0.04 $W/m \cdot K$) in series, area 10 m², with indoor air $h_i n = 10W/m^2K$ and outdoor air $h_{out} = 25W/m^2K$.

- First, find each R:

$R_{\text{conv,in}} = 1/(10 * 10) = 0.01$ K/W.
$R_{\text{wood}} = 0.02/(0.13 * 10) \approx 0.0154$ K/W.
$R_{\text{insul}} = 0.05/(0.04 * 10) = 0.125$ K/W.
$R_{\text{conv,out}} = 1/(25 * 10) = 0.004$ K/W.
Now, series sum: $R_{\text{total}} = 0.01 + 0.0154 + 0.125 + 0.004 = 0.1544$ K/W. This is the total resistance from room air to outside air.

- If inside is 20°C and outside is 0°C, $\Delta T = 20K$. So $Q = 20/0.1544 = 129.5$ W. That's the heat loss through the wall.

- Notice most of the resistance came from the insulation (0.125 of the 0.1544 K/W). Indeed the insulation caused about 81% of the total resistance, thus ~81% of the temperature drop will be across it. We can find temperatures: At inside air-film interface: $T_{\text{inner surface}} = T_{\text{inside air}} - QR_{\text{conv,in}} = 20 - 129.5 * 0.01 = 18.7°C$. After wood: $T_{\text{after wood}} = T_{\text{inner surface}} - QR_{\text{wood}} = 18.7 - 129.5 * 0.0154 \approx 16.7°C$. After insulation (outer surface): $T_{\text{outer surface}} = 16.7 - 129.5 * 0.125 \approx 0.4°C$. Then the outside air-film: $T_{\text{outside air}} = T_{\text{outer surface}} - QR_{\text{conv,out}} \approx 0.4 - 129.5 * 0.004 = -0.12°C$, which is essentially ~0°C as expected (rounding aside). The largest drop was inside surface (18.7) to outer surface (0.4) – mostly across insulation ~16.3°C drop, whereas wood had ~2°C drop, air films ~1.3°C combined. This demonstrates how the network approach quantifies each drop.

- If there were a parallel path, say a metal rod through the wall (which we didn't have in this example), we'd calculate R of the rod path (which would be much smaller since metal k is high but cross-sectional area of rod is small relative to 10 m² perhaps). Then combine with $R_{insulation}$ via $1/R_{\text{eq}} = 1/R_{\text{rod}} + 1/R_{\text{insulation}}$ for that segment of wall. The presence of a low-resistance rod would dramatically increase Q, and you'd see a much smaller effective R_{total}.

In summary, the thermal resistance network method is about **breaking a complex heat flow problem into simple resistive elements**. Master this method and you'll handle most conduction questions on the FE with confidence: just identify layers, assign resistances, add or combine appropriately, and compute Q and any temperatures needed. It's a straightforward, almost mechanical process once you practice it, very much in line with the FE exam's problem-solving style.

K12.T01.S04 – Extended Surfaces (Fins) Basics & Fin Efficiency/Effectiveness

Principle Introduction:

- **Why fins?** Fins (extended surfaces) are added to a hot object to **increase the surface area** available for heat transfer (usually convective cooling to a fluid). Common examples: cooling fins on an engine or motorcycle cylinder, heatsinks on electronics, radiator fins. By adding a fin, you give heat more area to leave the object, ideally removing heat faster.

- **Fin basics:** A fin is typically a piece of high-conductivity material (often metal like aluminum) attached to a base object. Heat is conducted from the base into the fin and then removed by convection from the fin surfaces to the surrounding fluid. The fin's temperature is highest at the base and drops towards the tip, because it's losing heat along the way. The **fin equation** (a differential equation) describes the balance between conduction along the fin and convection from its surface. Solutions of that

equation tell us temperature distribution and total heat dissipated by the fin.

- **Fin performance metrics:** Two important concepts are **fin efficiency** and **fin effectiveness**.

- **Fin efficiency ($\eta_f in$):** This is the ratio of the fin's actual heat loss to the maximum possible heat loss if the entire fin were at the base temperature. Essentially, how efficiently the fin's material is being used. If the fin were uniformly as hot as the base, it'd be removing the max possible heat for its size – but in reality the tip and parts of the fin are cooler, so they don't remove as much heat. Efficiency is always ≤ 100% (or ≤1 in decimal), with thicker/shorter fins (or higher conductivity materials) typically having higher efficiency (closer to 1) because they don't drop much temperature internally.

- **Fin effectiveness (ε_{fin}, sometimes noted as ε or φ):** This is the ratio of the heat removed by the fin to the heat that would be removed from the same base area if the fin were not present. In other words, does the fin actually improve heat transfer and by how much? If a fin is ineffective ($\varepsilon_{fin} < 1$), it means the fin isn't worth it – it's removing less heat than that area would have without the fin (this can happen if a fin is very long in a low conductivity material or very thin such that it barely conducts heat but adds surface area that doesn't help because it's almost the same temp as ambient at the tip). Usually, we design fins to have $\varepsilon_{fin} > 1$, often many times larger than 1. For example, a well-designed fin might have an effectiveness of 10, meaning it removes ten times the heat that the bare area would.

- **Fin equation parameters:** A typical straight fin of uniform cross-section can be characterized by a parameter $m = \sqrt{\frac{hP}{kA_c}}$, where h is the convective heat transfer coefficient, P is the perimeter of the fin cross-section (wetted perimeter that's losing heat), and A_c is the cross-sectional area of the fin (through which conduction happens). The ratio $hP/(kA_c)$ basically compares how much the fin wants to lose heat through convection vs how much it can conduct heat along. A large m means convection dominates (thin fin, high h, low k), so the fin might cool off quickly along its length. A small m means conduction dominates (thick, high k, low h), so the fin stays warmer along its length, utilizing more of its material.

- **Boundary conditions:** Two common fin tip conditions: (1) **Adiabatic tip (no heat loss at tip)** – an approximation for fins where the tip is small or maybe insulated. (2) **Convective tip** – tip also convects to the fluid (more accurate generally). There's also the case of an infinitely long fin (in theory, tip temperature → fluid temperature). On the FE exam, if needed, they'll likely give you either the formula or assume adiabatic tip for simplicity. Adiabatic tip yields a slightly simpler expression for fin efficiency and heat flow. Convective tip can be handled by defining an **effective fin length** L_c (corrected length) which is $L + t/2$ for a rectangular fin (where t is thickness), or $L + D/4$ for a cylindrical pin fin, accounting for the extra surface at the tip. Using L_c in place of L in the adiabatic formula gives a good approximation for a convective tip case.

Equation Passport – Fin Heat Transfer and Efficiency
Name & Purpose: Fin Heat Equation (adiabatic tip) – gives the heat transfer rate from a straight fin and the temperature profile along it, under the assumption that no heat is lost from the tip (worst-case for efficiency). This equation helps compute exactly how much heat a fin can remove and leads to definitions of fin efficiency and effectiveness. (Note: We'll focus on results rather than deriving the differential equation solution due to exam scope.)

Governing Equation (Temperature profile): For a uniform cross-sectional fin with adiabatic tip, the temperature excess (above ambient) at a distance x from the base is:

$$\frac{T(x) - T_\infty}{T_b - T_\infty} = \cosh\big(m(L - x)\big) / \cosh(mL).$$

Here T_b is the base temperature, T_∞ is the fluid temperature, and L is the fin length. This formula (from solving $d^2T/dx^2 = m^2(T - T_\infty)$ with boundary $dT/dx|_{tip} = 0$) describes how temperature drops along the fin. At $x = 0$ (base), $T(0) = T_b$. At $x = L$ (tip), we get $T(L) - T_\infty = \frac{1}{\cosh(mL)}(T_b - T_\infty)$, meaning the tip is cooler than base depending on mL.

Fin Heat Transfer (total Q from fin):

$$\begin{aligned} Q_{\text{fin}} &= hP(T_b - T_\infty)\frac{\sinh(mL)}{\cosh(mL)}\frac{1}{m} \\ &= \sqrt{hPkA_c}\,(T_b - T_\infty)\tanh(mL). \end{aligned}$$

These two forms are equivalent (using identity $\tanh = \sinh/\cosh$). The second form $Q_{\text{fin}} = \sqrt{hPkA_c}\,(T_b - T_\infty)\tanh(mL)$ is often easier: it shows $Q_{\text{fin}} = (kA_c m)(T_b - T_\infty)\tanh(mL)$ and since $m = \sqrt{\frac{hP}{kA_c}}$, $kA_c m = \sqrt{kA_c hP}$. This is the *actual* heat the fin dissipates given the tip condition.

Fin Efficiency (η_{fin}):

$$\eta_{\text{fin}} = \frac{Q_{\text{fin}}}{hPL(T_b - T_\infty)}.$$

The denominator $hPL(T_b - T_\infty)$ is the heat the fin *would* release if its entire surface (area = $P \times L$ for the sides, ignoring tip) were at base temperature T_b. So efficiency is actual heat over this ideal heat. Substituting the Q_{fin} above, for an adiabatic tip straight fin:

$$\eta_{\text{fin}} = \frac{\sqrt{hPkA_c}\tanh(mL)}{hPL} = \frac{\tanh(mL)}{mL}.$$

Thus $\eta_{\text{fin}} = \frac{\tanh(mL)}{mL}$ for an adiabatic tip fin. If mL is small (<~0.3), $\tanh(mL) \approx mL$ so $\eta \approx 1$ (very efficient, hardly any drop). If mL is large (>~3), $\tanh(mL) \approx 1$ but mL is large, so efficiency ~1/(mL) (which is small – long fin, low efficiency).

Fin Effectiveness (ε_{fin}):

$$\varepsilon_{\text{fin}} = \frac{Q_{\text{fin}}}{hA_{\text{base}}(T_b - T_\infty)}.$$

Here A_{base} is the area the fin occupies on the base (basically the footprint of the fin, which is area you'd otherwise just have convecting if fin weren't present). For a single fin, A_{base} might be just the cross-sectional area attached to the wall. Often, fins are arrays so we define effectiveness per fin. If $\varepsilon_{\text{fin}} > 1$, the fin improves heat transfer compared to no fin (which is usually the goal). Using Q_{fin} formula: $\varepsilon_{\text{fin}} = \frac{\sqrt{hPkA_c}\tanh(mL)}{hA_{\text{base}}}$. Many fins are thin plates or pins, so A_{base} is small (just the area where fin meets base), making ε quite high. If a fin is very efficient (η ~1) and has large area compared to base, ε can be huge. But note if k is very low or fin is very slender, Q_{fin} might be low and ε could be <1.

Variables and Units:

- T_b – base temperature (K or °C)

- T_∞ – ambient fluid temperature (K or °C)

- P – perimeter of fin cross-section (m) (total edge length that is exposed to fluid along fin length; for a rectangular fin of width w and thickness t, $P = 2(w + t)$ if both sides contribute; for a cylindrical fin (pin) of diameter D, $P = \pi D$).

- A_c – cross-sectional area of fin (m²) through which heat conducts (e.g. width **thickness** for rectangular, $\pi D^2/4$ for round pin).

- L – length of fin (m) measured from the base to tip.

- h – convection heat transfer coefficient of fluid (W/m²·K) around the fin.

- m – fin parameter, $m = \sqrt{\frac{hP}{kA_c}}$ (1/m).

- Q_{fin} – heat transfer rate from the fin (W).

- η_{fin} – fin efficiency (dimensionless, often expressed as percentage).

- ε_{fin} – fin effectiveness (dimensionless).

- A_{base} – base area (m²) that the fin attachment covers (for a single fin, this is often the cross-sectional area at the base; for an array, you'd consider total base area taken by all fins vs total base area available – but typically effectiveness is given per fin).

(All temperatures differences $T_b - T_\infty$ should be in K or °C consistently. As always, ΔT in K = ΔT in °C.)

Assumptions & Scope:

- The above formulas assume **steady-state** conditions (fin temperature profile not changing with time).

- **1D conduction along the fin:** We assume temperature only varies along the length x of the fin, not across the thickness (this is valid if the fin material is uniform and thin enough that internal lateral gradients are negligible – usually a good assumption for high-k metal fins).

- **Uniform h over the fin surface:** The convection coefficient h is taken constant along the fin and over all its surfaces. In reality, h might vary with position, but FE problems assume an average constant h.

- **Negligible radiation:** Usually we consider convection as the only mode of heat loss from fin (unless stated otherwise). If radiation is significant, an effective h could be augmented by a radiation term, but that complicates things beyond FE typical scope.

- **Tip conditions:** The efficiency formula we gave (tanh(mL)/(mL)) is for an **adiabatic tip**. If the tip loses heat, efficiency is a bit lower; a more general efficiency expression exists, but likely the exam won't require that unless they provide it. They might simply mention using the corrected length L_c: for a convective tip, you can approximate by using $L_c = L + t/2$ for a rectangular fin (t is thickness), or $L_c = L + D/4$ for a pin fin, then use the adiabatic formula with L_c. This effectively accounts for some tip loss.

- **When to use fins:** Fins are beneficial when h is low (poor convection) or the base area is limited – by adding a fin, you significantly boost heat transfer. If h is extremely high (like in boiling), fins might not be worth it. If fin material k is low (like trying to make a fin out of wood, which is silly), the fin will just act as an insulator beyond a certain length. The exam might ask conceptually, "under what conditions is adding fins *not* useful?" (Answer: when $\varepsilon_{fin} < 1$, i.e. usually if fin material is too insulating or h is so high that extra area doesn't help because base already convects well.)

Limit Checks:

- If $k \to \infty$ (an infinitely conductive fin), then $m \to 0$. In the formula $\eta_{fin} = \frac{\tanh(mL)}{mL}$, as $mL \to 0$, $\tanh(mL) \approx mL$, so $\eta_{fin} \to 1$. That matches expectation: a perfect conductor fin stays at base temperature throughout, using 100% of its area effectively. Q_{fin} in that case would approach $hPL(T_b - T_\infty)$ (the max possible).

- If k is very low or fin is very long (so mL is large), $\tanh(mL) \to 1$ but $mL \gg 1$, so $\eta_{fin} \approx 1/(mL)$, which goes to 0 as length $\to \infty$ or conductivity $\to 0$. That means an extremely long or poorly conducting fin essentially contributes negligible extra heat – beyond a certain length, adding more fin doesn't remove much additional heat because the far end is almost at ambient temperature. The effectiveness in such a limit might approach some constant or even drop if fin becomes a liability (though ε by definition >0, it can be <1 if fin actually insulates more than it helps).

- Fin effectiveness: If fin has no extension (imagine "fin" of zero length, just flush), $\varepsilon_{fin} = 1$ trivially (no improvement). As fin length increases a bit, ε rises. If $L \to \infty$ theoretically, the fin tends to a certain maximum heat removal which, if the fin becomes essentially ambient temp at the end, additional length doesn't help – effectiveness tends to some asymptotic value. Usually though, fins are sized to get diminishing returns beyond a certain L. If you keep making a fin longer and it's not doing anything extra, you're just adding useless material. So practically, one uses efficiency and effectiveness to decide an optimal fin length (where additional length maybe yields small % more heat). On the exam, they might test understanding that **there is diminishing return**: doubling fin length doesn't double heat removal, especially if it was already long.

- If $h = 0$ (no convection, hypothetically), then $m = 0$. The fin wouldn't lose any heat (no environment to lose to), so $Q_{fin} = 0$. Our formula in that edge case: $h \to 0$ gives $mL \to 0$, $\tanh(mL)/(mL) \to 1$, but also the prefactor $\sqrt{hPkA_c} \to 0$. So $Q_{fin} \to 0$. Good. If h is extremely large (like blowing air strongly), m is large, which tends to make $\tanh(mL) \to 1$ and if m huge then $Q \approx \sqrt{hPkA_c}(T_b - T_\infty)$. Actually if $h \to \infty$, the fin is instantly cooling any exposed bit, making it effectively tip at ambient almost immediately – ironically, infinite h would remove infinite heat in theory if base stays at T_b, but in practice base would drop. The key understanding: fins shine when h is moderate to low; if h is high, the base itself convects well so fins might not be needed.

Use vs. Alternatives: Use fin formulas when you have a **known fin geometry** and need to compute heat loss or temperature distribution. If the exam problem explicitly mentions fins or extended surfaces, they often either give you a formula to use or expect you to recall the efficiency/effectiveness concept qualitatively. If you don't have the fin formula at hand, you can sometimes apply an energy balance: assume some average fin temperature or just know that $Q_{fin} = \eta_{fin} * hPL(T_b - T_\infty)$. If a fin

is very efficient, you approximate $\eta \approx 1$; if very long, maybe treat the far end at ambient (like an infinitely long fin assumption yields $Q = \sqrt{hPkA_c}(T_b - T_\infty)$ which corresponds to $\tanh(mL) \approx 1$). In contrast, if a problem gives you the choice to use more fins or increase h by a fan, etc., realize adding fins is more effective when h is low. Sometimes exam conceptual questions might ask, "Given identical weight of fin material, is it better to have few thick fins or many thin fins?" – The answer lies in efficiency: too thin might make η low; too thick might be fewer fins (less area). Usually, an optimal exists. But that's beyond calculation – likely conceptual: e.g., many thin fins maximize area but could be inefficient if they're too long/low k; fewer thick fins have high efficiency but less total area.

Common Exam Traps:

- **Mixing up efficiency vs effectiveness:** They sound similar but mean different things. Efficiency is always ≤1 (≤100%) and is about the fin's own utilization of area. Effectiveness can be >>1 and is about improvement over no fin. The exam might ask for one or the other. For instance, "The fin efficiency is 80%" vs "The fin effectiveness is 5" – know what each implies. An 80% efficient fin means 20% of its area is "wasted" in a sense due to temperature drop. An effectiveness of 5 means that fin yields 5 times the heat flow compared to the bare surface. It's possible to have high effectiveness but moderate efficiency: e.g., a very long fin might be only 50% efficient (half of it is doing most of the work) but still have high effectiveness because that half still added a lot of area relative to no fin.

- **Using the wrong area in formulas:** In $m = \sqrt{\frac{hP}{kA_c}}$, P and A_c refer to different aspects (perimeter vs cross-section). Occasionally, someone might plug the fin surface area instead of perimeter times length. Remember $P * L$ (plus tip if any) gives total surface area for convection (excluding base), while A_c is for conduction. Also, when computing η_{fin}, use $P * L$ as the total area (except base) for ideal heat in denominator. For ε_{fin}, use base area A_{base} in the denominator (not the whole fin area!). It's easy to accidentally swap areas – double-check definitions.

- **Units consistency:** Ensure h is in W/m²K, P in m, A_c in m², k in W/mK, so that m comes out in 1/m, and mL is dimensionless (as it should). Then $\tanh(mL)$ is dimensionless, etc. The result for Q will be in W if everything is SI. If using U.S. units in a rare case (BTU/hr, ft², etc.), likely the exam gives values consistently or expects use of an equivalent formula – but normally they'll stick to SI in heat transfer.

- **Applying fin formula outside its scope:** Fin formulas given assume a particular shape (straight constant cross-section fins). If you have a different geometry like a triangular fin or an annular fin, the efficiency formulas differ. FE probably won't throw that at you unless giving you the formula. If in doubt, fall back to basics: small element analysis or just know that you can calculate $\eta = Q_{actual} / \left(hA_{surface}(T_b - T_\infty)\right)$ for any fin if you manage to get Q_{actual}. But generally, stick to straight fins (rectangular or cylindrical pins) as standard cases.

- **Ignoring the fin's base connection:** Realize that fins conduct heat from the base – so the base itself must supply that heat. If too many fins are attached to a small base, the base could cool significantly or have non-uniform temperature. In basic analysis we assume base is maintained at T_b constant (like a large heat source so its temp doesn't drop). On the exam, if base temp is given, assume it stays at that. If they ask something like "adding fins will reduce the base temperature if base isn't maintained" – that's a nuance but not likely asked explicitly. Just be aware: fins don't *create* heat, they only remove what base provides.

Exam Handbook Search Cues (Not affiliated with or endorsed by NCEES): *"fins"*, *"fin efficiency"*, *"fin effectiveness"*, *"fin equation"*. The handbook has a section on fins (likely listing formulas like we did for rectangular and pin fins, perhaps a mention of L_c for tip). It probably lists the efficiency η = tanh(mL)/(mL) result and maybe defines effectiveness. Use those keywords to quickly find the relevant snippet during the exam if needed.

Explanation (Understanding fin operation and when they help): Think of a fin as a highway for heat to leave a hot object – but a highway that also leaks cars (heat) along its way. At the base, heat enters the fin by conduction. As it travels outward, heat "exits" the fin via convection to the surrounding air. So the further along you go, the less heat is left to continue, and thus the temperature drops (like water pressure dropping along a leaky pipe). If the fin is very conductive (large k) and/or short, it doesn't lose much temperature by the end – the whole fin stays relatively warm, meaning it's effectively radiating heat along its entire length (high efficiency). If the fin is long or low k, by the time you get near the tip, the temperature is near ambient – that portion of fin isn't doing much (low efficiency). However, that fin could still have added a lot of area, so total heat removal might still be a few times what the base alone could do (so effectiveness could be >1 even if efficiency is low). The key idea: **efficiency tells you how well a fin uses its material; effectiveness tells you if the fin was worth having at all.** Ideally, you want both to be high – but if you have to trade off, effectiveness >1 is non-negotiable (otherwise the fin is counterproductive), while efficiency you might tolerate a bit lower if that's the design needed to reach certain heat removal. On exam problems, if asked qualitatively, "how to improve fin efficiency?" – answers: use higher thermal conductivity material, make the fin shorter or thicker (to reduce mL), or lower the convection coefficient (which might seem counterintuitive – a lower h means less heat lost per length so the fin stays warmer; though that also lowers total heat transfer potential, so usually you don't intentionally lower h, you instead adjust geometry or k). If asked, "how to improve fin effectiveness?" – basically increase the fin's area relative to base (more/larger fins) *but* ensure efficiency isn't too low (so there's an optimal point). Also, increasing h increases effectiveness of existing fin by removing heat faster (though it also can reduce efficiency slightly because more heat removal means faster cooling along fin – but net effect is more heat out). Typically, using a fan (increase h) plus fins yields a big boost in cooling.

In summary, fins are a practical tool to enhance heat transfer when you have a small base area and need to dump heat to a fluid. For the FE exam, know the formula for fin efficiency and effectiveness, and know how to apply them or interpret them. For instance, a question might give you a fin efficiency and ask for actual heat dissipated given base temperature and fin dimensions, or give you fin dimensions and ask for efficiency. Or a conceptual question: "All else equal, a copper fin will have higher efficiency than a steel fin – why?" (Answer: copper's higher k means less temperature drop along fin). Being comfortable with $m = \sqrt{hP/(kA_c)}$ and what it implies will allow you to reason through such comparisons. If a formula is needed, the exam likely supplies it, but recognizing the scenario ("this is a fin problem!") is on you.

Analysis (Term-by-term and special notes for fins): Let's parse the fin heat formula $Q_{fin} = \sqrt{hPkA_c}\,(T_b - T_\infty)\tanh(mL)$. There's a lot encoded in that:

- The factor $\sqrt{hPkA_c}$ has units: $\sqrt{W/m^2K * m * W/mK * m^2} = \sqrt{W^2/K} = W/\sqrt{K}$. When multiplied by $(T_b - T_\infty)$ (in K), it gives W, good. It's like an effective conductance. Notice it increases with k and A_c (better conduction) and with P and h (more area to convect, and better convection). So bigger k, A_c push Q up, as do bigger h, P. If hP is much larger relative to kA_c, it means the fin is "leaky" (wants to lose heat faster than it can conduct it in), which tends to saturate $\tanh(mL)$ quickly to 1, but limits Q by the fact that conduction can't supply more than a certain amount. If kA_c is huge relative to hP, then mL can be small, $\tanh(mL) \approx mL$, and the product yields Q ~ $kA_c(T_b - T_\infty)L$ for small fins (which basically means the fin is so conductive it just dumps heat uniformly).

- The $\tanh(mL)$ part is interesting: it always yields a number ≤1. For short fins, $mL \ll 1$, $\tanh(mL) \approx mL$, so $Q \approx \sqrt{hPkA_c}(T_b - T_\infty) * (mL) = \sqrt{hPkA_c}(T_b - T_\infty) * \sqrt{\frac{hP}{kA_c}}L = hPL(T_b - T_\infty)$. That reduces exactly to $h *$ (fin surface area) $* \Delta T$. Meaning a very short fin just acts like a small flat plate of area PL at nearly uniform temperature T_b. For long fins, $mL \gg 1$, $\tanh(mL) \to 1$, so $Q_{max} = \sqrt{hPkA_c}(T_b - T_\infty)$. That's the asymptotic heat removal if fin were infinitely long (it approaches a finite limit because eventually the far end contributes negligible additional heat). So you can see that doubling fin length beyond a certain point doesn't double Q; it approaches a cap. Designers pick fin length such that maybe fin gets something like 90% of that asymptote to avoid diminishing returns.

- Fin efficiency formula $\eta = \tanh(mL)/(mL)$: examine extreme cases: $mL \to 0$ gives η→1 (as discussed). $mL \to \infty$ gives η→0 (in theory). If $mL = 1$, η = tanh(1)/1 ~ 0.76. If $mL = 2$, η ~ tanh(2)/2 ~ 0.964/2 ~ 0.482. If $mL = 3$, η ~ 0.995/3 ~0.331. So roughly, if the fin length is such that mL ~ 2 or 3, efficiency is around 50% or 33%. That's often acceptable depending on design – means the outer half or two-thirds of the fin is underutilized but still giving some extra heat.
- Fin effectiveness often isn't explicitly computed with formula on FE (unless a simple case), but qualitatively: If you had to compute it, you need A_{base}. For example, a fin of width w and thickness t has base area $A_{base} = w * t$. If it's a pin of diameter D, $A_{base} = \pi D^2/4$. Then $\varepsilon = \frac{\sqrt{hPkA_c}\tanh(mL)}{hA_{base}}$. Simplify that for a rectangular fin: $P = 2(w + t)$, $A_c = wt$, $A_{base} = wt$ as well. So $\sqrt{hPkA_c} = \sqrt{h * 2(w + t) * k * (wt)}$. Hard to simplify outright, but if t is small compared to w, P $2w$ (if both large faces count but in convection usually both faces of fin + edges so P includes both sides plus thin edges; if t << w, edge contribution is minor). Without diving too deep: a bigger perimeter or more fins (like an array) increases total base area too in a way, so often we talk about overall fin array effectiveness or overall heat transfer coefficient including fins. But that's beyond one fin's discussion. The exam might just ask if adding N fins of a certain efficiency helps and by how much (maybe effectively the base area is increased by $Nfin$ *area efficiency). For a single fin, if effectiveness > 2 or 3, it's doing quite well. If it's barely above 1, it's not worth it.*

- *A special note: They sometimes define an* overall surface efficiency for a finned surface, which accounts for multiple fins and the unfinned portion, but that's likely too detailed for FE. Just mentioning that efficiency we did is per fin. If many fins cover a base, the overall efficiency is weighted by area.

Calculator note: If you had to calculate something like $\tanh(mL)$, the exam allows calculators that can do hyperbolic functions either directly or via the identity $\tanh = \frac{e^x - e^{-x}}{e^x + e^{-x}}$. The TI-36X Pro, for example, has hyperbolic function keys (accessible via menus). Casio fx-115 might also have them (like "sinh" "cosh" keys). If not, you can always compute it from exponentials. But likely if a numeric needed, mL will be a nice value or you won't need high precision. They could also present a ratio that simplifies (like maybe use the efficiency formula directly if mL is given or easily computed). Always ensure you're in radian mode? Actually hyperbolic doesn't matter radian/degree (they're not trig, they're exp-based), so that's fine. If using the identity, watch out for large exponents (they might blow the calculator for big mL) – but if mL is big, tanh ~1, which you can just approximate. So e.g. if $mL = 3, e^3 = 20.1$, $e^{-3} = 0.05$, you can manage. If $mL = 5$, e^5~148, e^-5~0.007, $tanh$~$(148 - 0.007)/(148 + 0.007)$~0.9999 (basically 1). So any mL beyond maybe 3 or 4 you can treat tanh as ~1 for practical engineering guess (maybe 4 gives 0.9993, essentially 1).

Alright, that wraps up our deep dive into conduction, covering Fourier's fundamental law, steady conduction through various geometries (with thermal resistances), how to combine those in networks, and finally how fins extend our heat transfer capability with measures of their performance. Mastering these will prepare you for virtually any conduction-related question on the FE Mechanical exam. Happy heat-flowing!

Topic 02 - Convection

Topic Overview: Convection is the mode of heat transfer in which thermal energy is carried away by a moving fluid (gas or liquid) in contact with a surface. It matters on the FE Mechanical Exam because many practical heat transfer problems involve cooling or heating objects with fluids – think of air cooling a hot engine or water carrying heat in a pipe. Convection problems on the exam typically ask you to calculate the heat transfer rate from a surface (using **Newton's Law of Cooling**) or to determine the convective coefficient **h** for a given flow scenario (using **Nusselt number correlations** for external or internal flows, or interpreting **Grashof/Rayleigh numbers** for natural convection). The key is recognizing the type of convection (forced external flow, forced internal flow, or natural convection) and then applying the appropriate formula or correlation. On exam day, you'll use the provided reference handbook to look up these formulas quickly – but you must know *what* to look for and *how* to use the formulas correctly. In this chapter, we break down each critical convection subtopic into a "passport" format so you know exactly how to approach it under exam conditions.

K12.T02.S01 – Newton's Law of Cooling (Convective Heat Transfer)

Principle Introduction:

- **Surface convective heat loss:** Newton's Law of Cooling relates the **heat transfer rate** from a surface to the fluid to the temperature difference between the surface and the fluid. It basically says that a hotter surface will lose heat to a cooler fluid at a rate proportional to how hot it is relative to the fluid.

- **Convective heat transfer coefficient (h):** The constant of proportionality is **h**, the convective heat transfer coefficient. This coefficient depends on the fluid properties and flow conditions (e.g. air vs water, forced flow speed, etc.), and it has units of W/(m²·K). A higher **h** means the fluid can carry away heat more effectively (for example, **h** is large for water or forced air, and small for still air).

- **Linear law (analogy to Ohm's Law):** Newton's law of cooling is **linear** with respect to the temperature difference. It is often compared to Ohm's law in electricity – temperature difference is like voltage, heat flow is like current, and **1/(hA)** is like a thermal resistance. This linear relationship makes it straightforward: double the difference in temperature, and you double the heat transfer rate (if **h** and area remain the same).

- **Direction and sign:** By convention, if the surface is hotter than the fluid, we consider heat flowing *from* the surface *to* the fluid (cooling the surface). The formula can be used in magnitude form for the rate of heat transfer **out of the surface**. Be mindful of sign conventions: a positive **q** can be defined as heat leaving the surface. If the fluid is warmer than the surface, the same formula applies but heat flow will be into the surface (cooling the fluid/heating the surface). The important point is the *difference* $\boldsymbol{T_s - T_\infty}$ sets the direction (if it's positive, heat leaves the surface).

Equation Passport – Newton's Law of Cooling
Name & Purpose: Newton's Law of Cooling – calculates the convective heat transfer rate from a surface to a fluid (or vice versa) using a convective coefficient. This is the go-to equation whenever you have a surface at temperature $\boldsymbol{T_s}$ exposed to a moving or stagnant fluid at temperature $\boldsymbol{T_\infty}$. It gives the heat transfer **q**, which is crucial for sizing cooling systems, finding heat loss, etc. on the FE Exam.

Formula (Convection heat transfer rate):

$$q = h\,A\,(T_s - T_\infty)$$

(For a surface hotter than the fluid, $T_s - T_\infty$ is positive and q is the heat leaving the surface. Conversely, if the surface is cooler than the fluid, this difference is negative, indicating heat flowing into the surface.)

Variables and Units:

- q – Heat transfer rate (W, watts). This can be the total heat leaving the surface. Sometimes you'll see $\mathbf{q''}$ (W/m²) used for *heat flux* (heat transfer **per unit area**); in that case $q'' = q/A = h(T_s - T_\infty)$.

- h – Convective heat transfer coefficient [W/(m²·K)]. Represents how effectively the fluid convects heat at the surface. **h** is typically given or found from correlations; it is not a fixed property and can vary widely: for free convection in gases it might be ~5–10 W/(m²·K), for forced air maybe 20–100, and for liquids or boiling it can be hundreds or thousands.

- A – Surface area through which convection occurs (m²). It's the area of the object in contact with the fluid. Larger area means more opportunity for heat transfer. If only a portion of an object's surface is exposed, use that area.

- T_s – Surface temperature (K or °C). The temperature at the solid/fluid interface (often a wall, plate, or object's surface). Use absolute temperature (K) for consistency in calculations; though here a difference $T_s - T_\infty$ appears, so using °C difference yields the same result as K difference.

- T_∞ – Fluid temperature away from the surface (K or °C). "T infinity" represents the bulk undisturbed fluid temperature far from the surface. For a large room it's the ambient air temp; for a pipe it might be the bulk fluid temp in the flow. Again, use K if plugging into formulas with constants, but for the difference it's fine in °C.

Assumptions and Scope:

- **Steady state, single-phase:** Newton's law assumes a steady situation (temperatures constant in time). It applies to a single phase (no phase change at the surface – that would be a different process like boiling, which has its own correlations).

- **Convective regime defined by h:** All the complex physics of the boundary layer and fluid motion are captured in **h**. This equation doesn't tell you **h** directly; it just tells how **q** relates to **h**. So you use this after you either know **h** or have a way to get **h** (empirical correlations, given data, or special cases).

- **Small temperature difference (optional):** Newton's law of cooling is essentially a linear approximation. It works best when the temperature difference isn't extreme such that properties stay fairly constant. In typical exam problems, this linear relation is fine.

- **Surface temperature is uniform:** We assume the entire surface is at temperature $\boldsymbol{T_s}$. If the surface temperature varies over a large area, you might have to use an average or integrate, but exam problems usually simplify this by giving a uniform or average $\boldsymbol{T_s}$.

Limit Check (Sanity Checks):

- If the **temperature difference** goes to zero ($\boldsymbol{T_s \to T_\infty}$), the heat transfer rate **q** → 0. That makes sense – no driving force, no heat flow. If you ever compute a nonzero **q** with equal temperatures, something's wrong.

- If the **convective coefficient** were zero (**h → 0**), the formula gives **q → 0**. Interpreted physically: **h = 0** would mean an *insulating* fluid that can't carry heat at all – indeed no convection occurs. Conversely, as **h** grows large (extremely efficient convection), for a given ΔT the heat flow **q** will be very large. There's effectively no upper bound in theory; in practice **h** is limited by the fluid and flow conditions.

Use vs. Sibling Equations: Use **Newton's law of cooling** for convective heat exchange at a surface **instead of** Fourier's law (conduction) or the Stefan–Boltzmann law (radiation) when you're dealing with a fluid medium moving over a surface. If you have a composite situation (say a solid conducting heat to the surface and then convecting away), you might use Newton's law at the boundary in combination with conduction equations inside the solid. But for any "surface cooling into a fluid" problem on the FE exam, Newton's law is the first tool to apply.

Common Exam Traps:

- **Unit consistency:** Ensure that area **A** is in m² if **h** is in W/(m²·K) and **T** in °C or K. If areas are given in ft² or temperatures in °F in a USCS-unit problem, you must convert **h** appropriately or use consistent units. The exam may give **h** in BTU/(hr·ft²·°F) for an imperial units problem, for example – be careful to use matching units for **q** (BTU/hr) in that case.

- **Sign confusion:** It's easy to mix up the sign if you blindly plug numbers. Remember $q = hA(T_s - T_\infty)$ is basically the heat leaving the surface **if** $T_s > T_\infty$. If the surface is cooler, this formula would give a negative q, which just means heat is entering the surface. In most exam questions, you'll likely be asked for the magnitude of heat transfer or a rate of heat loss, so you can just report $q = hA|T_s - T_\infty|$ and then state the direction ("from the surface to the fluid" or vice versa). A common mistake is to drop a negative sign incorrectly – if you're unsure, describe the direction in words to avoid losing points.

- **Overusing Newton's law:** Remember this gives the instantaneous heat transfer rate at a given $\boldsymbol{T_s}$ and $\boldsymbol{T_\infty}$**.** If the problem involves a cooling object over time (transient cooling), Newton's law can still apply at each moment, but you might need to integrate it or use a lumped capacitance model. Some students confuse Newton's law of cooling with the *transient cooling formula* (which is an exponential decay of temperature over time). The exam might have a separate formula for transient cooling (the *lumped capacitance* solution); don't mix these up. Newton's law is the basic rate equation, not the time-dependent solution itself.

Exam Handbook Search Cues (Not affiliated with or endorsed by NCEES): *Newton's law of cooling; convective heat transfer coefficient;* $q = hA\Delta T$*; heat flux convection* (These are the keywords you'd use to find this formula in the exam reference handbook. For instance, searching "cooling" or "convective coefficient" should locate Newton's law of cooling in the Heat Transfer section of the handbook.)

Footnotes:

- *Temperature difference:* In convection calculations, you often use ΔT between surface and fluid. Remember that a difference in Celsius is equal to a difference in Kelvin. So whether you plug temperatures in as 80°C and 20°C (difference 60°C) or 353 K and 293 K (difference 60 K), the ΔT of 60° is the same magnitude. It's usually safest to convert to Kelvin in formulas if absolute temperature matters elsewhere, but here $hA(T_s - T_\infty)$ only cares about the difference.

- *Convective coefficient values:* The convective coefficient **h** is not a universal constant – it's determined by things like fluid velocity, viscosity, thermal conductivity, etc. For example, **h** for **natural convection** of air might be ~10 W/(m²·K), whereas **forced convection** of water in a pipe could be ~500–1000 W/(m²·K). On the exam, if they don't give **h** explicitly, you're usually expected to compute it via dimensionless correlations (coming up in the next sections) or pick it from provided data.

- *Analogy to electrical circuits:* If you encounter *thermal resistance* in a problem, the convection at a surface can be represented as a resistance $R_{\text{conv}} = \frac{1}{hA}$. This is just a rearrangement of Newton's law: $q = \frac{T_s - T_\infty}{R_{\text{conv}}}$. Sometimes exam questions involve a series of thermal resistances (like conduction through a wall *and then* convection off the surface). It helps to remember this analogy so you can set up the thermal network correctly.

Variations & Related Forms:

- **Heat Flux Form:** As mentioned, you might see the formula given in terms of heat flux q'' (W/m²): $q'' = h(T_s - T_\infty)$. This is just the per-unit-area version. It's useful if the exam asks for something like "heat flux" or if the area is 1 m² for simplicity. Don't confuse q'' with q; q'' is not the total heat, but heat *density*.

- **Convective Cooling vs. Heating:** Newton's law is the same whether the surface is cooling (losing heat) or heating (gaining heat from the fluid). The difference is simply the sign of $T_s - T_\infty$. Some texts write $q = hA(T_{\text{surface}} - T_{\text{fluid}})$ and assume you'll put the correct temperatures in the correct place. Just remember it's always surface minus fluid in this convention. If you accidentally subtract the opposite way, you'd just get a negative number corresponding to heat going the other direction.

- **Combined Convection and Radiation:** In reality, a hot object in air cools by both convection *and* radiation. On the exam, these modes might be treated separately. If a problem says an object is losing heat by convection and radiation, you'd have a convection term $hA(T_s - T_\infty)$ and a radiation term $\varepsilon\sigma A\left(T_s^4 - T_{\text{surroundings}}^4\right)$. Be careful to distinguish these. Newton's law only covers the convective portion. (Radiation is covered by the Stefan–Boltzmann law – a different topic.)

Special Notes (Calculator tips): This formula is straightforward to compute on any calculator. Just be sure to enter it as $q = h \times A \times (T_s - T_\infty)$. It's a simple multiplication. If you're working in scientific notation (say, **h** might be 25 W/m²K, $A = 5\text{m}^2$, $\Delta T = 40K$), just multiply through carefully. No special calculator functions are needed beyond basic arithmetic. One thing to watch: if you're using a unit like BTU/hr for **q**, keep track of conversion factors (1 W = 3.413 BTU/hr) if needed – but typically, stick to SI units to avoid extra conversion steps on exam problems.

Explanation (How to Use Newton's Law): Concretely, when an exam problem gives you a convective heat transfer scenario, your first step is to identify the temperatures of the surface and the fluid. Next, find or calculate the convective coefficient **h** (either it's given, or you'll determine it from the flow conditions using correlations – which we'll cover in upcoming subtopics). Then identify the area over which convection is happening. Finally, plug into $q = hA(T_s - T_\infty)$. For example, if a problem says *"A 1.0 m² hot plate at 80°C is cooled by air at 20°C with convective coefficient 25 W/m²·K. Find the heat loss."* – you'd simply do $q = 25 \times 1.0 \times (80 - 20) = 1500$ W. Always double-check that the surface area you use is correct (only count the sides exposed to fluid) and that **h** is appropriate for that area (if the object has different **h** on different sides, handle each side separately). Newton's law is straightforward, but *using it correctly relies on good bookkeeping of what values go where*.

Analysis (Deep Dive into Terms and Pitfalls): Let's break down the terms physically: $q = hA\Delta T$. The **driving force** is $\Delta T = T_s - T_\infty$. If this difference is large, there's a strong push for heat flow; if it's small, not much heat moves. The **area** A tells us "how big of a window" the heat has to move through – larger area, more heat transfer (imagine a bigger radiator). The **convective coefficient** h is the tricky part: it encapsulates the fluid dynamics. **h** will be higher if the fluid is moving fast, or if it has high thermal conductivity, etc. For instance, blowing air on a hot cup of coffee increases **h**, thus increasing q (cooling the coffee faster). If instead the air is still, **h** is low and the coffee cools slowly. On the exam, you won't derive **h** from first principles (that's complex), but you should know qualitatively what affects **h**: fluid velocity (higher velocity → higher **h**), fluid viscosity (more viscous fluids tend to reduce **h** because they create thicker boundary layers), fluid thermal conductivity (higher k in fluid → higher **h**), and the nature of flow (turbulent flows generally yield higher **h** than laminar flows because mixing brings more cold fluid in contact with the surface).

A common pitfall in analysis is confusing **h** (heat transfer coefficient) with thermal conductivity **k** of a material. **k** is for conduction inside materials, whereas **h** is an *effective* parameter for convection at a surface. They are not the same, though **h** does depend on **k** of the fluid in a correlation (as we'll see via the Nusselt number). Another thing to analyze: if someone increases the area **A** (say, adding fins to a heat sink), the product **hA** effectively increases, so q increases for the same ΔT. If **h** or **A** or ΔT appear in the denominator of another formula (like in the lumped capacitance time constant $\tau = \frac{\rho V c_p}{hA}$), increasing **h** or **A** will decrease that time constant, meaning faster cooling. Always consider the physical meaning: more area or better convection equals more heat transfer. If your calculated result defies that logic (for example, you computed that adding fins *reduced* heat transfer), then there's a mistake to find. In summary, Newton's law of cooling is simple but foundational – you'll use it directly in some exam questions, and even when you're applying more complex correlations, it's often the last step after finding **h**. Master it, keep track of units, and you're off to a strong start in any convection problem.

K12.T02.S02 – External Flow Convective Correlations (Flat Plates & Cylinders)

Principle Introduction:

- **External forced convection:** This subtopic deals with heat transfer when a fluid flows over a *surface or object* that is immersed in it – for example, air blowing over a flat plate or across a cylinder. In such cases, the convective heat transfer coefficient **h** is not given explicitly; instead, it must be determined from empirical **correlations** that relate **h** (or rather a dimensionless form of **h**) to the fluid flow conditions.

- **Dimensionless groups (Re, Pr, Nu):** The key to these correlations are three dimensionless numbers: the **Reynolds number (Re)**, the **Prandtl number (Pr)**, and the **Nusselt number (Nu)**. **Reynolds number** (in this context, $Re_L = \frac{\rho u_\infty L}{\mu}$ for a flat plate of length L, or $Re_D = \frac{\rho u_\infty D}{\mu}$ for a cylinder of diameter D) indicates whether the flow is laminar or turbulent as it moves past the object.

Prandtl number $Pr = \frac{c_p \mu}{k}$ is a property of the fluid that relates momentum diffusivity (viscosity) to thermal diffusivity; it basically indicates how the thickness of the velocity boundary layer compares with the thickness of the thermal boundary layer**.**

Nusselt number $Nu = \frac{h\,L}{k}$ (for a length scale L like the plate length or cylinder diameter) is the dimensionless measure of convective heat transfer; essentially, it's the ratio of convective heat transfer to purely conductive heat transfer across the boundary layer.

- **Empirical correlation usage:** In external flow, we use experimentally derived formulas of the form $Nu = C \cdot Re^m \cdot Pr^n$ (sometimes with added terms or piecewise definitions) to find **Nu**, and from that we solve for **h** because $h = \frac{Nu\,k}{L}$. There isn't one single formula that covers all scenarios; instead, there are specific correlations for specific geometries and flow regimes. The exam will provide or expect you to recall the standard ones: for example, a **laminar** boundary layer over a flat plate, a **turbulent** boundary layer over a flat plate, or the standard correlations for **crossflow over a cylinder** (often presented as charts or tables for various Reynolds-number ranges).

- **Laminar vs Turbulent flow regimes:** A critical step is determining if the flow over the object is laminar or turbulent. For a flat plate, this typically depends on Re_L (based on plate length from the leading edge): if Re_L is below a certain transition (around 5×10^5 for a smooth flat plate under typical conditions), the boundary layer is laminar; beyond that, it becomes turbulent. For a cylinder in cross-flow, the flow might transition to turbulence at a different Re_D (often around $Re_D \sim 2 \times 10^5$ for flow separation behavior, but in heat transfer correlations, they often break it into ranges like 10^3–10^5, etc.). The point is, each regime has its own correlation formula. Using a laminar correlation in a turbulent regime (or vice versa) will give wrong results – a classic exam trap is failing to identify the regime correctly.

- **Flat plate vs other geometries:** The simplest case is a flat plate with flow parallel to it (like wind over a flat board). We often distinguish between *local* coefficients (at a specific distance x from the leading edge) and *average* coefficients (over the entire plate of length L). Most exam problems will ask for an average heat transfer coefficient over the plate, in which case you use the correlation for Nu_L (Nusselt based on full length L). For other shapes like cylinders or spheres, the correlations usually give you an average coefficient over the entire object's surface. The exam reference will often have these formulas or a chart of coefficients; your task is to pick the right one, plug in Re and Pr, and compute **Nu** (then **h**).

Equation Passport – Laminar/Turbulent Flat Plate Correlations

Name & Purpose: Flat Plate Nusselt Number Correlations – provide the average convective heat transfer coefficient **h** for a fluid flowing over a flat plate, by relating it to the flow's Reynolds and Prandtl numbers. Use these when you have flow *along* a flat surface (like air over a solar panel or oil over a flat plate heater) and need to find **h** to then compute convective heat loss via Newton's law. We present both the laminar and turbulent forms here, as both could be needed depending on the Reynolds number.

Formulas (Average Nusselt number for flow over a flat plate of length L):

For **laminar flow** over the full length (valid roughly for $Re_L \lesssim 5 \times 10^5$):

$$Nu_L = 0.664\, Re_L^{1/2}\, Pr^{1/3}$$

For **turbulent flow** (when Re_L is high, typically $Re_L \gtrsim 5 \times 10^5$; fully turbulent flow over the plate):

$$Nu_L = 0.0366\, Re_L^{0.8}\, Pr^{1/3}$$

These give the dimensionless Nusselt number over the entire plate. Once Nu_L is found, the convective coefficient is obtained by $h = \frac{Nu_L\, k}{L}$, where k is the thermal conductivity of the fluid.

(In these formulas, it's assumed fluid properties like k, μ, c_p (hence Pr) are evaluated at the film temperature, which is approximately the average of surface and fluid temperature. The exam may specify this or assume you use properties at a given reference temperature.)

Variables and Units:

- Nu_L – Nusselt number (dimensionless). It quantifies how much convection increases heat transfer through a fluid layer compared with conduction alone across an equivalent layer thickness. $Nu_L = \frac{hL}{k}$. A higher Nu means better convection (higher **h** for the same conditions).

- Re_L – Reynolds number (dimensionless) for the length **L** of the plate: $Re_L = \frac{\rho u_\infty L}{\mu} = \frac{u_\infty L}{\nu}$. Here u_∞ is the free-stream fluid velocity (m/s), L is the plate length in the flow direction (m), ρ is fluid density (kg/m³), μ is dynamic viscosity (Pa·s or N·s/m²), and $\nu = \mu/\rho$ is kinematic viscosity (m²/s). Re_L is unitless; it basically measures how many momentum diffusion lengths (viscous lengths) fit into the physical length – large Re means inertial forces dominate (likely turbulent), small Re means viscous forces dominate (laminar flow).

- Pr – Prandtl number (dimensionless): $Pr = \frac{c_p\, \mu}{k}$ (using fluid properties: c_p in J/(kg·K), μ in Pa·s, k in W/(m·K)). Equivalently $Pr = \nu/\alpha$ where $\alpha = k/(\rho c_p)$ is thermal diffusivity. Pr indicates how fast momentum diffuses vs heat diffuses in the fluid. Pr is ~0.7 for air (meaning thermal and momentum diffusivities are comparable), ~7 for water (meaning momentum diffuses much faster than heat, leading to thinner thermal boundary layers), and can be 1000+ for oils. The exponent 1/3 in these correlations is standard for many situations where thermal boundary layer growth is "normal."

- h – Convective heat transfer coefficient [W/(m²·K)], as before. It's what we usually want to find. After computing Nu_L, you solve $h = Nu_L\, k/L$. Note that the length **L** in that formula must be consistent with how Nu_L was defined (for a flat plate, it's the total plate length along the flow).

- k – Thermal conductivity of the fluid [W/(m·K)]. Important: use the fluid's thermal conductivity, not the solid's. In convection correlations, k is always the fluid's property because Nusselt is defined in terms of heat transfer through the fluid's boundary layer.

- *(Constants 0.664, 0.0366, and exponents 1/2, 1/3, 0.8 are dimensionless fitting parameters derived from theory/experiment. Memorize the form: 0.664 and 1/2 exponent for laminar, 0.0366 and 0.8 exponent for turbulent – they're commonly provided, but it helps to recognize them.)*

Assumptions and Scope:

- **Flat plate, flow parallel:** These specific formulas assume a flat plate geometry where the flow comes in parallel to the plate (boundary layer developing on a flat surface from the leading edge). They also assume the flow is not disturbed by the plate significantly (no separation, etc., which is true for a flat plate aligned with flow). For bluff bodies like cylinders, different correlations (or charts) must be used – see variations.

- **Constant properties (evaluated at film temperature):** The derivation of these correlations assumes fluid properties like viscosity and thermal conductivity don't change drastically in the boundary layer. In practice, if the surface and fluid temperatures differ a lot, you use the average (film) temperature to get properties for Re and Pr. On the FE exam, if needed, they will either provide property values at a specified temperature or instruct you to assume some average. If not stated, assume properties at the given fluid temperature or the midpoint between fluid and surface temp.

- **Fully developed turbulence for turbulent correlation:** The turbulent correlation given assumes the plate is long enough that the flow has transitioned to turbulence early and the entire plate (or most of it) is under turbulent flow with an established turbulent boundary layer. If the flow transitions from laminar to turbulent partway, technically the average Nu is a mix; but a common simplification (and exam strategy) is to check the Re_L. If Re_L is well above 5×10^5, you might assume predominantly turbulent and use the turbulent formula. If it's below, use laminar. If it's borderline, the exam might ask specifically for the point of transition or split the plate (laminar on part, turbulent on rest); however, that level of detail is rare without explicit guidance.

- **Flows without flow separation:** For the flat plate, there's no separation (the flow clings to the surface in a boundary layer). For other shapes like cylinders or spheres, flow separation can occur, but their correlations inherently account for that in certain Re ranges.

- **No significant form drag effects on h:** In external flow, if an object is very thick or has a blunt shape, flow separation can dramatically alter the heat transfer. The standard correlations assume typical scenarios (like a cylinder or sphere correlation assumes an average over possibly separated flow). Just be aware scope-wise: use these formula for standard cases as listed; don't apply flat plate formulas to a short stubby object or vice versa.

Limit Checks:

- If the **flow velocity** u_∞ is extremely low (approaching 0), $Re_L \to 0$. Plugging that into the laminar correlation $Nu_L = 0.664 Re_L^{1/2} Pr^{1/3}$ would give $Nu_L \to 0$, hence $h \to 0$. That aligns with physical expectation: with no forced flow (still fluid),

convective heat transfer goes to zero *in the limit* – actually in reality, at zero flow you'd be in pure **natural convection** regime, which is a different correlation. So one should not literally use the forced convection correlation at very low Re; instead, switch to free convection analysis when Re is extremely low. But as a check, it's good that it doesn't produce a nonsensical negative or something.

- If **Re is very high**, say $Re_L \to 10^7$ or more, the laminar formula no longer applies; the turbulent formula might be used. The turbulent formula $Nu_L = 0.0366 Re_L^{0.8} Pr^{1/3}$ would predict a very high Nu. However, in reality at extremely high Re the correlations might change form or secondary effects appear (like compressibility if in gas at high speed). For FE exam purposes, you won't go to insane extremes; just stay within valid ranges (they usually mention the range of Re for which a correlation is valid – e.g. the above laminar correlation is from the Blasius solution for $Re < 10^5$ roughly). So if you accidentally used the laminar formula at $Re = 10^6$, you'd get Nu that is too low; conversely using turbulent correlation at $Re = 10^4$ would give Nu too high. Always check the Re range to ensure you applied the right one.

- **Film temperature for properties:** A subtle "limit" type check is ensuring you used reasonable property values. If T_s and T_∞ differ greatly, using properties at one extreme might skew the result. Typically, taking an average temperature for properties yields more accurate correlation results. If the exam problem spans a big ΔT, they might hint at this or directly provide properties.

Use vs. Sibling Equations: Use these flat plate correlations **instead of** the cylinder or sphere correlations when the geometry is a flat surface. If you have a long pipe or plate vs a small object, pick the formula accordingly. If the scenario is internal flow (inside a pipe/duct), then you wouldn't use these external formulas; you'd use the internal flow correlations (next subtopic). Also, note that if a problem gives you **Stanton number** or friction coefficient relationships (sometimes $St = \frac{h}{\rho u c_p}$ is used, related via Reynolds analogy to skin friction), that's another sibling concept – but for the FE exam, it's rare to use Stanton number directly; you're more likely to stick to Nusselt forms.

Common Exam Traps:

- **Using wrong characteristic length:** For flat plates, L is usually the length along the flow direction. But for cylinders, the characteristic length is diameter D. Students sometimes mix up which length goes into Re and Nu. A classic mistake is to use the radius or circumference by accident. Remember: if the correlation says Nu_D, use diameter in both $Re_D = \frac{uD}{\nu}$ and in computing $h = Nu_D \frac{k}{D}$. If Nu_L for a plate, use the plate's length (flow direction length) for Re_L and $h = Nu_L \frac{k}{L}$.

- **Transition regime mis-handling:** What if Re_L is exactly around 5×10^5? Some might guess to average the two formulas or use a combined formula. The FE Handbook might explicitly give a combined correlation or guidance (some references use a formula that weights laminar and turbulent contributions). The exam likely won't make you do something too fancy; they might state "assume turbulent flow" if it's borderline, or the conditions will clearly be one or the other. A trap is to blindly pick turbulent correlation just because "flow is fast" without checking Re. Always compute Re first and compare to known transition values.

- **Not computing h**: After finding Nu, don't forget to finish the job. Many correlations give you Nu, but the question asks for heat transfer or h. You must convert Nu to h. This requires knowing k of the fluid. If the problem doesn't provide k, check if you are expected to know it (maybe a common value for air at room temp ~0.026 W/m·K) or if it's in a table in the handbook. A common slip is to present Nu as the answer or to plug Nu wrongly into Newton's law. The correct sequence: find Nu, then $h = \mathrm{Nu}\frac{k}{L}$, then use $q = hA\Delta T$ if needed.

- Mixing up local vs average Nu: If a problem specifically asks for the local heat transfer coefficient at a certain point x on a flat plate, the correlation is different: $Nu_x = 0.332 Re_x^{1/2} Pr^{1/3}$ (for laminar local) – note 0.332 vs 0.664 for average. The handbook has both in some references. Most likely, FE exam questions will ask for the average h over the entire length because that's more straightforward. Just keep an eye out: if they mention the distance or position, they might want local $h(x)$. Using the average correlation in that case would be an error.

Exam Handbook Search Cues (Not affiliated with or endorsed by NCEES): *Nusselt number; flat plate convection; external flow correlations; Reynolds number; Prandtl number; cylinder cross-flow Nu* (In the exam reference, these keywords will lead you to the section listing convection correlations for external flow. For example, searching "Nusselt flat plate" or "External flow" should jump to the formulas above, whereas "cylinder Nusselt" would show the correlation table for cylinders.)

Footnotes:

- *Property evaluation:* For these correlations, evaluate fluid properties at a **representative film temperature**, typically taken as the average of the surface temperature and the free-stream fluid temperature. For example, if the surface is at 100 °C and the air is at 20 °C, you would use properties around 60 °C when computing R_e and P_r.

- *Turbulent flow entry length:* Unlike internal flows, for external flow over a flat plate the transition to turbulence typically happens naturally after a certain distance. We often use a critical $Re_x \approx 5 \times 10^5$ to mark where laminar flow might transition. If a problem plate length is such that part is laminar and part turbulent, a more detailed calculation would split the plate. However, unless explicitly asked, you can simplify by seeing if the *entire* plate is likely laminar or turbulent. For instance, if the full length L gives $Re_L = 2 \times 10^6$, definitely the latter part is turbulent. The handbook correlation and many exam problems assume either fully laminar or fully turbulent for simplicity.

- *Flow over cylinders and spheres:* The flat plate has a nicely separable laminar/turbulent scenario. For a cylinder or sphere in cross flow, the flow is almost always going to transition and separate. The exam reference provides a table of constants for cylinders (as listed below in variations) and a formula for spheres. Remember, these are also "external flow correlations." We cover them next in variations, but just know the same principles of using Re, Pr, and finding Nu apply to those shapes too.

Variations & Related Forms:

- **Flow over a Cylinder (cross-flow): - Flow over a Cylinder (cross-flow):** When a uniform stream hits a round cylinder (like air blowing across a pipe or a rod), the boundary layer grows around the curved surface and typically separates, creating a wake. Because that behavior changes significantly with Reynolds number, cylinder convection is usually handled with a **single general correlation form** whose constants are **selected from a table/chart**

based on the computed Re_D, rather than switching between one "laminar plate" equation and one "turbulent plate" equation.

A common correlation template is: $Nu_D = C\, Re_D^m\, Pr^{\,n}$ where n is often close to $1/3$in many standard references, and C and m are **piecewise** (they depend on the Reynolds number range).

Procedure for exam problems (cylinder in cross-flow):

1. **Use the diameter as the characteristic length:** D (not radius, not circumference).
2. **Compute the Reynolds number:**

$$Re_D = \frac{\rho V D}{\mu} = \frac{VD}{\nu}$$

   with Vas the free-stream speed.

3. **Identify the correct Reynolds range** and pull the matching constants (C, m)(and any listed correction factor, if your reference includes one).
4. **Compute the Nusselt number:** $Nu_D = C\, Re_D^m\, Pr^n$ using fluid properties typically evaluated at a representative (film) temperature unless told otherwise.
5. **Convert $Nu_D$to the convection coefficient:**

$$h = \frac{Nu_D\, k}{D}$$

6. **Finish the heat transfer step if asked:** $q = hA\,(T_s - T_\infty)$ where for a long cylinder the outside area is usually $A = \pi DL$ (end effects often neglected unless the problem says otherwise).

- **Flow over a Sphere:** Spheres have their own correlation. A simple, popular correlation for a sphere is:

$$Nu_D = 2 + 0.6\, Re_D^{1/2} Pr^{1/3},$$

valid roughly for Re_D up to 10^5 (with some say from 10 to 10^5). Here the "2" accounts for the baseline heat transfer even at very low Re (pure conduction limit around a sphere yields $Nu \to 2$). If Re is extremely low (creeping flow, $Re < 1$), pure conduction is dominant and indeed $Nu \approx 2$ is the conduction around a sphere solution. The added term gives the enhancement from convection as Re increases. If Re is large, again flow separation etc. will require another formula or extension (some advanced correlations add another term like $0.6Re^{2/3}$ for higher range). But for the FE exam, if a sphere problem comes, this simple form might be given or used for moderate Re.

- **Other geometries:** There are correlations for flow over other shapes (like an array of tubes, or an angled flat plate, etc.), but those are beyond typical FE exam requirements. Usually, flat plate, cylinder, and sphere cover the bases. If ever needed, the exam will provide the specific correlation.

- **Influence of surface roughness:** Not usually accounted for in basic correlations, but roughness can trip a laminar flow to turbulent earlier. If a problem wanted to be tricky, they could mention a rough surface causing early transition (thus you might use turbulent correlation at a lower Re_L than 5×10^5). However, unless data is given, you won't be expected to adjust for roughness in convective heat transfer (it's more of a fluid mechanics head loss concern).

- **Typical h *values (for context):*** For air flow over a flat plate at 5 m/s (moderate speed) and length ~1 m, h might come out on the order of 20–50 W/(m²·K) (laminar) or up to 100+ W/(m²·K) if turbulent. For a cylinder in air at similar speeds, h is roughly of the same order. In water, because k is higher and Pr is higher, h can be in the hundreds or more. You don't need to memorize numbers; just know that **h** in forced convection is generally higher than in natural convection (next topic), often by a factor of 5 or 10 for the same situation.

Special Notes (Calculator Usage): When calculating Nusselt correlations on a basic scientific calculator, be mindful of the exponents: e.g., $Re_L^{1/2}$ means take square root of Re_L; $Re_L^{0.8}$ you'll use the x^y key (on the FE-approved calculators, you might have a y^x or x^{th} power button). For example, to compute $Re^{0.8}$, you'd enter Re, then the power key, then 0.8. Ensure you include the $Pr^{(1/3)}$ as well – it might be easiest to compute each part then multiply. A helpful tip: $Pr^{1/3}$ is the cube root of Pr. If your calculator doesn't have an obvious cube root button, you can do $Pr^{(1/3)}$ with the power key too. Or, since $1/3 = 0.3333$ ..., just raise to 0.3333. Some calculators may require parentheses: e.g., entering $0.664 * Re^{0.5} * Pr^{0.333}$. Always use enough parentheses to ensure the exponents apply correctly (especially if you combine in one line). Another tip: many FE problems will have nice round numbers or might simplify because maybe $Pr^{1/3}$ is close to 1 for air ($\sim 0.7^{0.333} \approx 0.89$). But carry the calculation precisely to avoid rounding errors. Also, watch out for very large or small Re – intermediate steps might overflow if you do something like $Re^{0.8}$ for a huge Re; better to use scientific notation. E.g., if $Re = 2 \times 10^6$, doing $Re^{0.8}$ might be easier by log math, but your calculator can handle it: $2e6^{0.8}$. Just keep track of the magnitude.

Explanation (Using External Flow Correlations): The approach in an exam question is usually: identify the geometry (plate, cylinder, etc.), determine the relevant length (L or D), compute the Reynolds number with given flow velocity and fluid properties, decide laminar or turbulent or find the correct range, then select the corresponding correlation. Compute Nu, then find h. Finally, perhaps use Newton's law $q = hA\Delta T$ to get the heat transfer. For example, suppose a problem says: *"Air at 20°C flows at 10 m/s over a 1 m long flat plate which is maintained at 50°C. Determine the convective heat transfer coefficient."* You'd: (1) calculate $Re_L = \frac{(1.2\ \text{kg/m}^3)(10\ \text{m/s})(1\ \text{m})}{1.8\times10^{-5}\ \text{Pa·s}} \approx 6.7 \times 10^5$. That's slightly above 5×10^5, so flow is transitioning to turbulent. Likely we use the turbulent correlation (or if being precise, maybe mixed – but exam would accept turbulent in this regime). (2) Use $Nu_L = 0.0366 Re_L^{0.8} Pr^{1/3}$. Air's Pr at 20–50°C ~0.7. So $Nu_L = 0.0366(6.7e5)^{0.8}(0.7)^{1/3}$. (3) Calculate that: $Re^{0.8} \approx (6.7e5)^{0.8} \approx (6.7^{0.8}) * (10^5)^{0.8} = \sim something * 10^4$, let's do it properly: $(6.7 \times 10^5)^{0.8} \approx 4.6 \times 10^4$(for sake of example). Then $Nu_L \approx 0.0366 * 1.3e5 * 0.89 \approx 4230$ (just a ballpark). (4) Now $h = Nu_L * k/L$. With air's k ~0.026 W/mK, $h \approx 4230 * 0.026/1 = 110 W/(m^2 \cdot K)$. So that's the convective coefficient. We would answer $h \approx 1.1 \times 10^2 W/(m^2 \cdot K)$. This process is typical: get Re, pick formula, compute Nu, get h. Each step is straightforward but prone to mistakes if you mix up formula or mis-calculate exponent. By practicing such steps, you'll be quick on exam day.

Analysis (Interpreting External Flow Results): Let's interpret what the correlation result means. In the above example, $Nu_L \approx 4230$ – that number by itself isn't intuitive, but it told us $h \approx 110$.

If we had erroneously assumed laminar and used the laminar formula at $Re = 6.7e5$, what would we get? Let's check: $Nu_L(laminar) = 0.664(6.7e5)^{0.5}(0.7)^{0.333}$. $(6.7e5)^{0.5} \approx 818$ (since $\sqrt{6.7 \times 10^5} = \sqrt{6.7\sqrt{10^5}} \approx 8.18 \times 10^2 \approx 818$). Then times 0.664 and 0.89 gives ~484. So laminar correlation would predict Nu 484 and thus h 484 $* 0.026 = 12.6 W/m^2K$. That's an order of magnitude smaller! This dramatic difference shows why using the correct regime matters: the turbulent mixing boosts heat transfer a lot. In reality, our flow was mostly turbulent, so 110 is the right ballpark. If you had given 13 W/m²K as answer, it would be clearly off for that high-speed scenario. The exam graders expect you to catch that logic – a high-speed flow should not give a heat transfer coefficient as low as free convection (which is around 10). So always reflect on your answer: does it make sense given the physics? Another analysis point: the Prandtl number's role. Notice that for air (Pr ~0.7) vs for water (Pr ~7), if everything else (Re) was same, water's higher Pr leads to a slightly higher Nu exponent effect ($Pr^{1/3}$of 7 is ~1.91, whereas for 0.7 it's 0.89). That means at same Re, water would have about double the Nusselt -> double the h compared to air, *aside from* water's thermal conductivity being higher too. So water convects heat much better both because of higher k and higher Pr. This aligns with intuition: blowing water over a hot surface cools it far faster than blowing air. The correlations capture these effects neatly.

Finally, consider how these external flow correlations might appear in combined problems: sometimes a problem might require you to compute heat loss from an object – you'd first compute **h** from these correlations, then plug into Newton's law with the surface area and ΔT. Or, conversely, an exam question might be conceptual: "If the velocity of air doubles, what happens to the convective heat transfer coefficient for laminar flow over a plate?" Using $h \propto Nu \propto Re^{1/2}$ (laminar), if velocity doubles, Re doubles (linearly with velocity), so Nu goes up by $2^{1/2}$ 1.414. Therefore h increases ~41%. Such proportional reasoning can be tested. For turbulent with power 0.8, doubling velocity would increase h by $2^{0.8}$ 1.74(74. Having these ballpark exponents in mind helps answer those "what if" questions quickly. It's all about understanding the correlation's structure, not just plugging numbers. Keep these insights in mind, and you'll handle external convection problems with confidence.

K12.T02.S03 – Nusselt Number (Definition)

Principle: The **Nusselt number** Nu is a dimensionless measure of convective heat transfer, defined as $\mathrm{Nu} = \frac{hL}{k}$, typically using the characteristic length $L = D$ (pipe diameter). It is defined as **convection normalized by conduction** through the fluid boundary layer; **a larger** Nu indicates that convection dominates more strongly over pure conduction.

Importance: In pipe flow problems, you compute h by first finding Nu from a correlation, then using $h = \mathrm{Nu}\, k/D$. Nusselt number links fluid flow (via Re, Pr) to the heat-transfer coefficient h.

Utility in FE: FE exam questions often ask for h or heat rate Q in flow. You would: compute Reynolds number, decide laminar or turbulent regime, then use a Nusselt correlation to get Nu, and finally h.

Formula (Definition Passport):

$$\mathrm{Nu} = \frac{h\,L}{k}$$

where h is the convective heat-transfer coefficient $[\mathrm{W}/(\mathrm{m}^2 \cdot \mathrm{K})]$, L is the characteristic length [m] (for internal pipe flow, $L = D$), and k is the fluid's thermal conductivity $[\mathrm{W}/(\mathrm{m} \cdot \mathrm{K})]$.

Variables & Units:

- h: convective coefficient [W/(m²·K)] (at film temperature)
- L: characteristic length [m] (for a tube, D)
- k: thermal conductivity [W/(m·K)]
- Nu: dimensionless

Assumptions/Scope: Steady, single-phase convection. Properties evaluated at bulk or film temperature. Used for engineering convective problems (not microscale or rare cases).

Limit Tests: As $h \to 0$, Nu → 0 (no convection). If h is extremely large, Nu → ∞ (strong convection).

Use vs. siblings: Use Nusselt instead of directly using h when applying empirical correlations. In FE context, always find Nu first via correlation, then compute h = Nu k/D.

Common Pitfalls: Mixing up h and Nu; forgetting that L (in denominator) for internal flow is diameter; using wrong units for k or h.

Exam Handbook Search Cues (Not affiliated with or endorsed by NCEES): *"Nusselt number definition"*, *"Nu = hD/k"*, *"Reynolds Prandtl Nusselt"*.

Footnotes: Always use SI units for k, D, h. In the exam handbook Nu is defined as hD/k. The fluid bulk temperature (or film temperature) is used for properties. Micro-check: If fluid is stagnant ($h = 0$), then $\mathrm{Nu} = 0$ (no heat transfer).

Variations: Some textbooks define Nu with other L (e.g. L = length of plate). In ducts always use $L = D$. Equivalent form: $h = \frac{\mathrm{Nu}\,k}{D}$. Typical values: Nu ≈ 4 for fully-developed laminar (tube); tens to hundreds for turbulent flow.

Special Notes (Calculators): No special calculator tricks; just compute h from Nu normally. Ensure you convert exponents properly (e.g. $10^{0.4}$ on TI).

Explanation & Analysis: The Nusselt number quantifies convective enhancement. In FE problems involving pipe flow, we *use* Nu correlations to find h. For example, after computing Re_D and Pr, you might get $\mathrm{Nu}_D = 50$. Then $h = 50 \cdot k/D$. Each symbol: $\mathrm{Re}_D = \rho V D/\mu$ (dimensionless Reynolds number), $\mathrm{Pr} = \mu c_p/k$ (dimensionless), k [W/(m·K)]. Be careful: ρ in kg/m³, V in m/s, μ in Pa·s. A common error is using viscosity at the wrong temperature (always check if correlation requires μ at wall or bulk temp).

K12.T02.S04 – Fully Developed Laminar Flow (Circular Tube)

Principle: For fully developed laminar flow in a circular tube with constant wall conditions, the Nusselt number takes a constant value. This is because the thermal boundary layer and velocity profile are fixed, so the convective heat transfer per unit length becomes uniform.

Scenarios: There are two wall-heat conditions: (a) **Uniform Heat Flux** (constant q''); (b) **Constant Wall Temperature** (T_w fixed). These give slightly different Nu values.

Equation Passport:

- **Name & Purpose:** Fully-developed laminar convective Nusselt number – used to compute h for steady laminar flow in pipes.
- **Equation:** $\mathrm{Nu}_D = 4.36$ for uniform wall heat flux and $\mathrm{Nu}_D = 3.66$for uniform wall temperature.
- **Variables & Units:** Nu_D as defined earlier. Here D is pipe diameter [m]; h [W/(m²·K)]; k [W/(m·K)]. The values 4.36 and 3.66 are dimensionless.
- **Assumptions:** Laminar flow ($\mathrm{Re}_D < 2300$), hydrodynamically and thermally fully developed (entry effects negligible), constant wall heat flux or wall temperature as specified, properties constant.
- **Limit Tests:** As $L/D \to \infty$ (very long tube), the flow fully develops and Nu_D indeed approaches 4.36 or 3.66. If somehow the condition flips (insulation, $h \to 0$), these formulas would not apply.
- **Use vs. siblings:** Use these constants only when flow is fully developed. If flow is developing or turbulent, **do not** use 4.36/3.66. Instead use entry-length correlations (for short tubes) or turbulent correlations (like Dittus–Boelter).
- **Common Traps:** Mixing up the two values: 4.36 is for constant heat flux at wall, 3.66 for constant wall temperature. A frequent mistake is using the wrong one. Also, students sometimes forget to convert tube diameter to hydraulic diameter if the duct is noncircular (use D_H, see next subtopic).

Exam Handbook Search Cues (Not affiliated with or endorsed by NCEES): *"laminar circular tube Nusselt 4.36"*, *"3.66 constant Tw"*, *"fully developed laminar flow"*.

Footnotes: Ensure flow is laminar. These values are taken from canonical solutions. Note: the handbook uses Nu_D notation, so search for "NuD 4.36 3.66" if using the exam handbook.

Variations/Related: If only one condition is mentioned, choose the matching constant. If flux vs temperature condition isn't clear, many problems assume **constant wall temperature** (use 3.66). Typical magnitude: around 4.

Special Notes (Calculators): No input trick needed, these are just numbers.

Explanation & Analysis: When you have fully developed laminar flow in a smooth tube, the Nusselt number is constant. In practice, calculate Re_D to check laminar (usually $\mathrm{Re}_D < 2300$). Then decide boundary condition:

- **Uniform heat flux:** $\mathrm{Nu}_D = 4.36$.
- **Constant wall temperature:** $\mathrm{Nu}_D = 3.66$.

Each corresponds to a classic analytic solution. Physically, constant heat flux means the wall temperature gradually rises downstream, giving a slightly higher average Nu. The difference (4.36 vs 3.66) stems from how the thermal boundary layer develops.

After finding Nu_D, compute $h = \mathrm{Nu}_D\, k/D$. For example, if $k = 0.6$ W/mK, $D = 0.05$ m, and $\mathrm{Nu}_D = 3.66$, then $h = 3.66 \cdot 0.6/0.05 \approx 44$ W/(m²·K). A common pitfall: using these constants outside their range. If Re_D is higher (turbulent), using 3.66/4.36 would be wrong (you'd underpredict h).

K12.T02.S03 – Dittus–Boelter Correlation (Turbulent Flow)

- **Principle:** The **Dittus–Boelter equation** gives the average Nusselt number for **fully turbulent** flow in a smooth circular tube. It is an empirical correlation relating Nu_D to Reynolds and Prandtl numbers.
- **Applicability:** Valid for $\mathrm{Re}_D \gtrsim 10^4$ and $0.7 \le \mathrm{Pr} \le 160$, and for tubes with $L/D > 10$. It assumes a uniform property and applies to both heating and cooling cases (with a slight exponent change).

Equation Passport:

- **Name & Purpose:** Dittus–Boelter equation – computes average Nu_D for turbulent flow in a circular tube.

- **Equation:**

  $$\mathrm{Nu}_D = 0.023\,\mathrm{Re}_D^{0.8}\,\mathrm{Pr}^n, \quad n = \begin{cases} 0.4, & \text{fluid being } \textbf{heated} \text{ (tube wall hotter)}, \\ 0.3, & \text{fluid being } \textbf{cooled} \text{ (tube wall cooler)}. \end{cases}$$

  (This form assumes $L/D > 10$ and properties at bulk temperature.)

- **Variables:**
  - $\mathrm{Re}_D = \frac{\rho V D}{\mu}$ (Reynolds number, dimensionless).
  - $\mathrm{Pr} = \frac{\mu c_p}{k}$ (Prandtl number, dimensionless).
  - n: exponent (0.4 for heating, 0.3 for cooling).

- **Units:** Dimensionless all around (the numbers 0.023, exponents, Re, Pr are all unitless).
- **Assumptions:** Steady, incompressible flow, fully turbulent, smooth tube, constant fluid properties, $L/D > 10$. Fluid is heated/cooled uniformly.
- **Limit Tests:** As $\mathrm{Re}_D \to 10^4$, this formula approaches its lower validity limit. If $\mathrm{Re}_D \to \infty$, $\mathrm{Nu}_D \to \infty$ (higher turbulence boosts convection). If Pr is very small or very large (beyond range), accuracy drops.
- **Use vs. siblings:** Use Dittus–Boelter instead of Sieder–Tate when fluid properties vary little with temperature (small ΔT). If viscosity changes significantly (e.g. very hot fluid), prefer Sieder–Tate.
- **Common Traps:** Forgetting the exponent n depends on heating vs. cooling; many students default $n = 0.4$ always. Also be careful with units: Re_D uses diameter D, not radius, and velocity of the **fluid** (not the tube). Often overlooked is checking the $L/D > 10$ condition (short tubes violate this).

Exam Handbook Search Cues (Not affiliated with or endorsed by NCEES): *"Dittus Boelter equation"*, *"*$0.023\,\mathrm{Re}^{0.8}\mathrm{Pr}^{0.4}$*"*, *"turbulent tube Nusselt"*.

Footnotes: The coefficient 0.023 and exponents come from experiment. Use fluid properties at mean (bulk) temperature. Re must be calculated with the tube diameter (or hydraulic diameter). Reminder: Reynolds number is dimensionless.

Variations/Related: A frequently used rearrangement: $h = 0.023\,k/D\,\mathrm{Re}_D^{0.8}\,\mathrm{Pr}^n$. Also, if you know mass flux G (kg/(m²·s)) and density ρ, then $V = G/\rho$. Typical turbulent Nu values are tens to a few hundreds (higher than laminar).

Special Notes (Calculators): On exam calculators, enter exponents carefully: e.g. for TI-30x, use Re^0.8 explicitly. Some calculators require a multiplication dot or parentheses: 0.023 * (Re^0.8) * (Pr^n).

Explanation & Analysis: Use Dittus–Boelter when you have turbulent flow inside a tube (high Reynolds). First compute $\mathrm{Re}_D = \rho V D/\mu$ and check $\mathrm{Re}_D > 10^4$. Compute $\mathrm{Pr} = \mu c_p/k$. Then plug into $\mathrm{Nu}_D = 0.023\,\mathrm{Re}_D^{0.8}\mathrm{Pr}^n$. The exponent n depends on heating (wall hotter than fluid, $n = 0.4$) or cooling ($n = 0.3$). For instance, a warm fluid heated by hot pipe wall uses $n = 0.4$. Once Nu_D is found, compute $h = \mathrm{Nu}_D\,k/D$. Common mistake: using wrong n. Also, keep units consistent: if ρ is in kg/m³, μ in Pa·s, D in m, then Re_D is dimensionless as required.

K12.T02.S05 – Sieder–Tate Correlation (High Property Variation)

Principle: The **Sieder–Tate equation** is a modification of Dittus–Boelter that accounts for viscosity differences between the bulk fluid and tube wall (important for large ΔT). It applies in turbulent flow when fluid properties vary with temperature.

Equation Passport:

- **Name & Purpose:** Sieder–Tate equation – computes Nu_D for turbulent pipe flow with significant viscosity variation.

Equation:

$$\mathrm{Nu}_D = 0.027\,\mathrm{Re}_D^{0.8}\,\mathrm{Pr}^{1/3}\left(\frac{\mu_b}{\mu_s}\right)^{0.14}$$

valid for $\mathrm{Re}_D > 10^4$, $0.7 < \mathrm{Pr} < 16$. Here μ_b is viscosity at bulk fluid temperature, μ_s at wall temperature.

Variables:

- μ_b, μ_s: dynamic viscosity [Pa·s] at bulk and wall temperatures.
- Other symbols as in Dittus–Boelter.

Assumptions: Fully turbulent, properties evaluated as stated, constant Pr range (usually liquids). Used when ΔT is large so $\mu_s \neq \mu_b$.

Limit Tests: If $\mu_b = \mu_s$, the ratio $(\mu_b/\mu_s)^{0.14} = 1$ and Sieder–Tate reduces to a form similar to Dittus–Boelter (with coefficient 0.027 vs. 0.023). If temperature differences are small, then $\mu_b \approx \mu_s$.

Use vs. siblings: Use Sieder–Tate instead of Dittus–Boelter when fluid viscosity changes significantly (e.g. hot oil cooling in tube, large ΔT). Otherwise, Dittus–Boelter is simpler.

Common Traps: Forgetting to raise μ_b/μ_s to the 0.14 power (typo in calculator); confusing which viscosity is used. Also, be aware that 0.027 coefficient differs slightly from 0.023 (a test trap is mixing these two).

Exam Handbook Search Cues (Not affiliated with or endorsed by NCEES): *"Sieder–Tate equation* $\mathrm{Re}^{0.8}\left(\frac{\mu_b}{\mu_s}\right)^{0.14}$, *"viscosity correction turbulent"*.

Footnotes: Viscosities should be in SI (Pa·s). If wall temp is unknown, sometimes assume film temp ($T_{\text{film}} = (T_w + T_b)/2$). Typical values of μ_b/μ_s range from 1 (no correction) up to several for oils.

Variations/Related: Can be written as $h = 0.027\,k/D\,\mathrm{Re}_D^{0.8}\mathrm{Pr}^{1/3}(\mu_b/\mu_s)^{0.14}$. For thin-walled tubes, $T_w \approx T_b$, so Sieder–Tate ≈ Dittus–Boelter.

Special Notes (Calculators): Input $(\mu_b/\mu_s)^{0.14}$ carefully (use parentheses).

Explanation & Analysis: After computing Re_D and Pr, use Sieder–Tate when fluid viscosity changes. Calculate μ_b at bulk fluid temperature and μ_s at wall temperature. Then compute Nu_D as above. For example, if $\mu_b = 0.001$ Pa·s and $\mu_s = 0.0008$ Pa·s, then $\mu_b/\mu_s = 1.25$, and $(1.25)^{0.14} \approx 1.03$. Thus the viscosity correction is small in this case. If temperature difference is extreme (say $\mu_b/\mu_s = 2$), that factor $\approx 2^{0.14} \approx 1.10$ significantly increases Nu. After Nu_D is found, proceed to $h = \mathrm{Nu}_D\,k/D$. A common mistake is using μ at the wrong reference; always use bulk for Re, and wall for μ_s in the formula.

K12.T02.S05 – Equivalent Hydraulic Diameter D_H (Definition)

Principle: In ducts that are **not circular**, use the *equivalent (hydraulic) diameter* D_H in place of D for flow correlations. This ensures that Reynolds and Nusselt numbers still apply.

Definition Passport:

- **Definition:** D_H is defined such that Re and Nu correlate similarly to a circular pipe. Mathematically,

  $$D_H = \frac{4\,(\text{cross-sectional area})}{\text{wetted perimeter}}.$$

  For a circular pipe, $D_H = D$. For a rectangular duct (sides a, b), $D_H = 2ab/a + b$.
- **Purpose:** Converts any shape's flow equations into "equivalent pipe" form, so you can use the same Nusselt correlations.
- **Units:** D_H is a length [m].
- **Usage:** Use D_H in place of D in $\mathrm{Re}_D = \rho V D/\mu$ and in Nusselt correlations. The "wetted perimeter" is the total perimeter in contact with fluid (for annulus, use outer perimeter plus inner diameter circle).
- **How to use (Exam-style):** Calculate area A and wetted perimeter P, then $D_H = 4A/P$. For example, a 2 m by 1 m

duct: $A = 2$, $P = 6$, so $D_H = 4(2)/6 = 1.333$ m. Then treat the flow as if in a 1.333 m diameter pipe.

- **Common Misreads:** Forgetting the factor of 4, or mixing up area vs perimeter. If both sides of a duct are in contact with fluid, include both in P. In some cases (annulus) you must use $D_H = D_o - D_i$ for cylindrical annulus.

Exam Handbook Search Cues (Not affiliated with or endorsed by NCEES): *"hydraulic diameter 4A/P"*, *"noncircular Nusselt"*.

Footnotes: Ensure units are consistent (e.g. all lengths in m). For fully open rectangular ducts, all four sides count in perimeter.

Variations/Related: Hydraulic radius $R_H = A/P$; $D_H = 4R_H$. For a circular annulus with outer diameter D_o and inner D_i, one formula is $D_H = D_o - D_i$ (valid for thin annulus).

Special Notes (Calculators): No special keys; just compute area and perimeter then divide.

Explanation & Analysis: In FE problems, you might see e.g. a square duct or annulus. First compute D_H and then proceed as if flow were in a circular pipe of that diameter. For example, a rectangular duct 0.1 m by 0.2 m has $A = 0.02$ m², $P = 2(0.1 + 0.2) = 0.6$ m, so $D_H = 4(0.02)/0.6 = 0.1333$ m. Then find $\mathrm{Re} = \rho V D_H/\mu$ and use the relevant Nu correlation. A common mistake is using the hydraulic diameter in the wrong place (for example, using it in the Nu definition but not in Reynolds number); be consistent.

Topic 03 - Radiation

Topic Introduction: Radiation is one of the three basic heat-transfer modes, along with conduction and convection. It is the transfer of thermal energy by electromagnetic waves, which means **no medium is required** – a hot object can radiate heat even through a vacuum (think of the Sun heating the Earth). On the FE Mechanical Exam, radiation questions typically involve calculating the heat emitted by a surface at a given temperature or comparing how different surface properties (like color or finish) affect radiative heat transfer. **Why it matters:** At high temperatures, radiation can dominate heat transfer, and understanding concepts like *blackbody vs. real surface emissivity* is key to solving these problems quickly on exam day. A common question archetype is using the Stefan–Boltzmann law to find radiative heat loss or identifying which surface (black, gray, or reflective "white" body) emits/absorbs more heat under the same conditions.

Key exam focus

- **Recognize blackbody vs. gray body:** Know that a blackbody is an ideal emitter/absorber (emissivity = 1), whereas real surfaces are gray bodies with emissivity < 1.
- **Use the Stefan–Boltzmann law confidently:** It's the go-to formula for radiative heat transfer: $Q = \epsilon\sigma A T^4$. Be ready to plug in values (with *absolute* temperature!) and solve for Q or T.
- **Surface properties impact:** Understand how **emissivity** (ε), **absorptivity** (α), and **reflectivity** (ρ) relate. For opaque surfaces, whatever isn't absorbed is reflected. Highly reflective "white" surfaces emit little heat, while matte black surfaces emit a lot.

(In this chapter, we'll build intuition on these concepts and make sure you're prepared to tackle FE problems involving thermal radiation.)

K12.T03.S01 – Stefan–Boltzmann Law & Emissivity (Blackbody Radiation Basics)

Principle introduction:

- Thermal radiation from a surface increases *dramatically* with temperature (it's proportional to T^4). Even a small rise in T can lead to a big jump in radiative heat output.

- A **blackbody** is an ideal surface that absorbs all incoming radiation (no reflection) and, at a given temperature T, emits the maximum possible thermal radiation. It's the reference for "100% efficiency" in emitting.

- Real surfaces are less effective emitters. We characterize each surface by its **emissivity** ϵ (0 < ε < 1), which is essentially the fraction of blackbody radiation it actually emits. Higher ε means the surface is closer to being a blackbody.

- **Stefan–Boltzmann law:** This fundamental law quantifies radiation heat transfer. It says that radiative heat flux **scales with the fourth power of the absolute temperature**. For a blackbody, the emissive power $E_b = \sigma T^4$. For a real surface, $E = \epsilon\,\sigma T^4$, and so the total radiated power from area A is $Q = \epsilon\,\sigma\,A\,T^4$.

Equation Passport: Stefan–Boltzmann Law

Name and purpose: *Stefan–Boltzmann Law* – calculates the radiant heat emission from a hot surface. It gives the *maximum* radiative heat flux for a given temperature (blackbody output), and adjusts for real surfaces via emissivity.

Equation:

$$Q = \epsilon\,\sigma\,A\,T^4,$$

which relates the radiative heat transfer Q from a surface to its temperature T.

Variables and units:

- Q = radiative heat flow (thermal power radiated) – *[W]* (watts)
- ϵ = emissivity of surface – *(dimensionless, 0 ≤ ε ≤ 1)*
- σ = Stefan–Boltzmann constant ≈ 5.670×10^{-8} – *[W/(m²·K⁴)]*
- A = surface area emitting radiation – *[m²]*
- T = absolute temperature of the surface – *[K]* (kelvin)

Assumptions and scope:

- Surface is **uniform in temperature** and behaves as a *diffuse gray body* (emissivity ε is constant and same for emission and absorption).

- Surroundings are large or effectively much colder than the surface (e.g., deep space). In that limiting case we often use $Q = \varepsilon\sigma A T^4$ to represent the power leaving the surface. When the surroundings are at a finite temperature T_{sur}, the relevant **net** radiative exchange is $Q_{\text{net}} = \varepsilon\sigma A(T^4 - T_{\text{sur}}^4)$. Valid primarily for thermal radiation in the infrared range at typical engineering temperatures, with Tmeasured on an **absolute** scale (Kelvin in SI, Rankine in USCS).

Limit tests (sanity checks):

- If $T = 0$ K (absolute zero), then $Q = 0$. A surface at 0 K emits no thermal radiation – makes perfect sense.
- If $\epsilon = 0$, then $Q = 0$. A perfectly reflective (ideal "white") surface emits no heat – it cannot radiate if it doesn't absorb anything.
- Doubling the absolute temperature T increases Q by **16**× (since $2^4 = 16$). *Example:* a blackbody at 600 K emits 16 times more power than at 300 K. Radiative output grows extremely fast with temperature.

Use vs. sibling equations: Use the Stefan–Boltzmann law for **radiative** heat transfer problems (heat exchange by thermal radiation across a vacuum or open space). Do **not** confuse it with Newton's Law of Cooling for convection ($Q = hA\,\Delta T$), which is linear in temperature difference and requires a fluid medium. If a problem mentions *emissivity*, *radiation*, or a body radiating in space, $Q = \epsilon\sigma A T^4$ is the appropriate formula (whereas convection involves an h and a ΔT, not T^4).

Common exam traps:

- **Wrong temperature scale:** Always convert °C or °F to **Kelvin** (or Rankine) before raising to the 4th power. *For example, 100°C is 373 K; plugging "100" into σT^4 would be wildly incorrect.*

- **Emissivity omission:** If emissivity isn't 1, don't ignore it. For instance, "90% emissive" means $\epsilon = 0.90$. Only use ε = 1 for an ideal blackbody (or if the question explicitly says "assume blackbody").

- **Mixing up flux vs. total:** σT^4 gives *power per unit area*. If the exam asks for heat **flux** (in W/m²), use $q'' = \epsilon\sigma T^4$ (no A). If it asks for total power, multiply by the surface area A. Don't accidentally square the area or apply it twice.

- **Ignoring surroundings:** If an object radiates in an environment that isn't at absolute zero, remember there is incoming radiation too. The exam might simplistically ignore this if not mentioned, but be mindful: net radiation is reduced if surroundings are warm. In formula terms, use the $T^4 - T_{\text{surr}}^4$ adjustment when appropriate (often the exam will hint at this by giving an environment temperature).

Exam Handbook Search Cues (Not affiliated with or endorsed by NCEES): *radiation, emissivity, Stefan–Boltzmann (constant)*

Footnotes:

- Use **absolute temperature** in all radiation formulas. The Stefan–Boltzmann constant value (5.67×10^{-8}) is in SI units, which require Kelvin. If working in U.S. customary units (rare in radiation problems), convert to Rankine or use the constant in those units.

- The symbol σ (sigma) here is a universal constant for radiation, not to be confused with stress or other σ in different contexts.

- Emissivity ϵ is often provided in problems. You're not expected to memorize emissivities, but know the trend: **black, dull, or painted surfaces** typically have high ε (~0.8–0.95), while **shiny metallic or reflective surfaces** have low ε (~0.05–0.2). This means shiny surfaces stay cooler by radiating less heat (and conversely, they absorb less).

- The Stefan–Boltzmann law gives an upper bound on emission. No real object emits more than σT^4. So if you calculate an absurdly high Q, double-check if ε < 1 or if T was in the wrong units.

Variations, related forms, typical values:

- **Net radiative loss:** When an object at T_1 radiates to surroundings at T_2, the net heat transfer is $Q_{\text{net}} = \epsilon\sigma A(T_1^4 - T_2^4)$. *Special case:* if the surroundings are very cold (like deep space, effectively 0 K), this simplifies to $Q \approx \epsilon\sigma A T_1^4$ (pure emission). If surroundings are near the object's temperature, net radiation can be much smaller.

- **Typical magnitudes:** At room temperature (~300 K), a blackbody emits about 460 W per square meter. At 1000 K, it emits ~56,000 W/m². That 1000 K (~727°C) object radiates roughly 120 times more heat per area than a 300 K object – illustrating how **hotter objects radiate disproportionately more**. On the exam, radiation is most significant in high-temperature scenarios (engines, furnaces, red-hot metal) rather than ambient conditions.

- **Emissivity examples:** A surface coated in **lamp black** or matte black paint (ε ≈ 0.95) will radiate almost as effectively as a blackbody. A **polished aluminum** surface (ε ≈ 0.05) radiates very little – only ~5% of blackbody power – it mostly reflects. This is why emergency blankets and insulation have shiny foil: to minimize radiative heat loss. Expect exam questions to give ε explicitly, but you should recognize that "a shiny silvered surface" implies a small ε, whereas "blackbody" or "black surface" implies ε ≈ 1.

- **Unit checks:** Ensure area is in m² and temperature in K when using σ = 5.67×10^{-8} in SI. If a problem gives area in cm² or temperature in °C, convert units first. Mixing units (like using A in ft² with σ in SI) will give the wrong answer. Keep an eye on units – it's an easy place to slip up under time pressure.

Special notes (calculator usage): All FE-approved calculators can handle T^4 easily. Use the exponent or power function (^ or x^y key) to raise temperature to the fourth power. For example, to compute 800^4, enter "800", then use the power key, then "4". Make sure you include parentheses if you do something like $\epsilon\sigma(T^4)$ in one sequence. Also, because T^4 grows large, use the calculator's scientific notation mode to keep track of significant figures (the result of 800^4 will be a big number). **Always double-check** that you converted temperatures to Kelvin before exponentiating – it's a common pitfall that the calculator won't warn you about!

Explanation & analysis:

Explanation (when & why to use it): Stefan–Boltzmann's law is used whenever you need to find heat transfer by *thermal radiation*. On exam day, that means any scenario of an object emitting heat without direct contact or fluid flow. For example, if a question asks "how much power does this hot object radiate?" or "what is the heat loss by radiation?", this is the formula to apply. It's also used in comparing materials: e.g. *"Which surface emits more heat: a black painted plate at 500 K or a polished steel plate at 500 K?"* – the one with higher ε (the black plate) emits more.

Analysis (step-by-step insight): Let's break down $Q = \epsilon\sigma A T^4$:

- T^4 **dependence:** Temperature is the most crucial factor. Because of the fourth power, radiative heat transfer is very sensitive to T. If you increase T a bit, Q increases a lot. Always convert to absolute temperature – the formula demands it. If you accidentally used °C, you'd severely underpredict or overpredict Q. *Mental check:* at 20°C vs 30°C, if someone used 20 and 30 instead of 293 K and 303 K, the ratio $(30/20)^4 = 2.5$ would wrongly suggest a 2.5× increase, whereas the true ratio $(303/293)^4 \approx 1.14$ is only 14% increase.

- **Emissivity (ε):** This factor linearly scales the ideal σT^4 to account for a real surface. Think of ε as a "efficiency" or percentage. ε = 1 (100%) for a perfect emitter, ε = 0.5 means the surface emits half the power of a blackbody at that T. So if two objects are at the same temperature but one has half the emissivity, it'll radiate half the power. *Practical note:* A common mistake is to forget ε or to use an incorrect value. The exam might test this conceptually (a shiny object stays cooler because it's radiating less heat away).

- **Area (A):** Radiative heat loss is proportional to area – a bigger hot surface emits more total power. If a problem gives you dimensions (say a plate of certain length/width) and asks for total heat loss, calculate the area. Conversely, if it asks for heat **flux**, that's per area, so you might not need the area term explicitly (or set A = 1 m² for convenience).

- **Constant σ:** The Stefan–Boltzmann constant is provided so you don't memorize it, but you should recognize it. Using it correctly is mostly about unit consistency. Remember it's a tiny number; if your computed Q seems off, check if you applied σ properly.

- **Putting it all together:** To solve a radiation problem, identify the given values (T, A, ε). Convert T to K, plug into $Q = \epsilon\sigma AT^4$, and compute. If solving for an unknown (like T given Q), isolate that term (e.g. $T = (\frac{Q}{\epsilon\sigma A})^{1/4}$). Don't be afraid of the fourth root – your calculator can handle it (use the ^(1/4) operation). Finally, interpret the result: does it make sense? A quick check using the limit tests (like $T = 0$ gives $Q = 0$, or higher ε gives higher Q) can validate that you set it up right.

By understanding this law, you can quickly eliminate wrong answers on conceptual questions (e.g., if one option ignores the T^4 dependence, it's likely incorrect) and confidently crunch the numbers for calculation problems. Remember, *radiation likes it hot* – the hotter the body and the higher the emissivity, the more energy it'll radiate.

K12.T03.S02 – Radiative Surface Types (Black, Gray, and White Surfaces)

Principle introduction:

- When thermal radiation hits a surface, it can be **absorbed**, **reflected**, or **transmitted**. These fractions are denoted by absorptivity α, reflectivity ρ, and transmissivity τ. For any surface, these add up to 1 (100% of the incoming radiation is accounted for): $\alpha + \rho + \tau = 1$.

- Most solid surfaces in engineering (metals, paints, etc.) are **opaque** to thermal radiation, meaning $\tau = 0$. In such cases, whatever energy isn't absorbed must be reflected, so $\alpha + \rho = 1$. If a material absorbs 70% of incident heat, it will reflect the other 30%, for example.

- A **gray body** is an idealization where the surface's emissivity ϵ is constant and equal to its absorptivity (at thermal equilibrium). This means the surface's efficiency at emitting radiation equals its efficiency at absorbing. Real objects often approximate this behavior, especially in the infrared range, so we typically assume $\epsilon = \alpha$ for calculations (gray surface assumption).

- **Black vs. white extremes:** A **blackbody** (ideal black surface) has $\alpha = 1$ and $\rho = 0$ – it absorbs all incident radiation (and thus emits maximally, $\epsilon = 1$). An ideal **white surface** is the opposite extreme: $\alpha = 0, \rho = 1$ – it reflects all radiation and absorbs none (so it would emit essentially nothing, $\epsilon \approx 0$). Real "white" or shiny surfaces aren't perfect, but they reflect most radiation and have low emissivities.

- The key relationship is that **good absorbers are good emitters**. A surface that absorbs a large fraction of radiation (black or dark, high α) will also emit a lot when hot (high ε). Conversely, a highly reflective surface (low α) emits little (low ε). This is Kirchoff's law in action and is why, for example, a black object heats up and cools down faster via radiation than a shiny one.

Equation Passport: Radiation Property Balance

Name and purpose: *Radiative energy balance on a surface* – expresses how incoming radiation is partitioned into absorption, reflection, and transmission. It ensures energy conservation for any radiative exchange with a surface.

Equation:

$$\alpha + \rho + \tau = 1,$$

representing 100% of incident radiation being either absorbed (α), reflected (ρ), or transmitted (τ).

Variables and units: *(All are dimensionless fractions of the incident energy, typically given as values between 0 and 1 or in %.)*

- α = absorptivity – fraction of incident radiation energy **absorbed** by the material.
- ρ = reflectivity (reflectance) – fraction of incident energy **reflected** (bounced off) the surface.
- τ = transmissivity – fraction of incident energy **transmitted through** the material (passes to the other side).

Assumptions and scope:

- The relationship α + ρ + τ = 1 assumes a steady state and a uniform incoming radiation on the surface. It's essentially an energy conservation statement – no energy is lost; it's either absorbed, reflected, or goes through.

- Values of α, ρ, τ generally depend on wavelength. However, for the FE exam we usually consider overall (broadband) behavior or assume the surface is "gray" (properties are approximately constant in the thermal spectrum). Under the **gray body** assumption, the emissivity ε equals α for the relevant thermal radiation wavelengths.

- **Opaque surfaces:** For most engineering materials (metals, paints, ceramics) in the thermal infrared, $\tau \approx 0$. Thus, α + ρ ≈ 1 for them. We often use this to find one if the other is known (e.g., if a plate reflects 80% of incident heat, α ≈ 0.20).

- **Thermal equilibrium:** Kirchhoff's law implies that, for a surface in thermal equilibrium with its surroundings, the emissivity equals the absorptivity, $\varepsilon = \alpha$. This is why a good absorber (high α) is a good emitter (high ε). Our calculations usually assume this equilibrium condition when relating ε and α.

Limit tests (special cases):

- **Blackbody:** Set $\rho = 0$ and $\tau = 0$. Then α = 1. The surface absorbs all incident radiation – this is the idealized blackbody (maximal absorber/emitter).

- **White body (perfect reflector):** Set $\alpha = 0$ and $\tau = 0$. Then ρ = 1. The surface reflects all incoming energy and absorbs nothing. An ideal mirror or a super-polished, shiny surface approaches this behavior.

- **Transparent body:** Set $\alpha = 0$ and $\rho = 0$, then τ = 1. All energy passes through (no absorb, no reflect). This is like an ideal clear material (e.g., some gases or a theoretical perfectly transparent window for the radiation in question). Note: in practice, if τ = 1, emissivity is zero too since nothing is absorbed to later emit.

Common exam traps and points of confusion:

- Don't mix up **reflectivity (ρ)** with **refraction** or other properties. ρ here strictly means the fraction of energy reflected, not an angle or index.

- The term "**white surface**" in heat transfer means high reflectivity/low absorption across thermal wavelengths – it does *not* literally require the object to be white-colored. For instance, polished metal (shiny silver) is "white" in the infrared sense (reflective). Conversely, a white paint might reflect visible light but still absorb some IR; the exam will usually make it clear by context or by giving ε or ρ values.

- Assuming **ε = α** at all times: The exam typically either gives emissivity directly or gives enough info to infer it. If a problem tells

you a surface's reflectivity, you might assume it's opaque (τ=0) and do $\varepsilon = \alpha = 1 - \rho$. This works under the gray body assumption. Just be cautious: if the surface is not opaque, then you'd also consider τ (but such cases are rare in exam problems unless dealing with glass or gases).

Exam Handbook Search Cues (Not affiliated with or endorsed by NCEES): *black body, gray body, absorptivity, reflectivity, opaque*

Footnotes:

- **Kirchhoff's Law:** For a given wavelength and temperature, a body's emissivity = absorptivity. The FE exam doesn't require you to delve into wavelength-dependent detail, but it underlies why we set $\varepsilon = \alpha$ for a gray surface. Just remember: a good absorber is a good emitter.

- In radiative exchange problems, if you see terms like "radiation shield" or "reradiating surface," those imply specific cases (like surfaces with $\varepsilon \to 0$ or effectively adiabatic surfaces). But for basic understanding, focus on the simple cases above (black vs. white).

- Real materials often have α and ε that vary with wavelength. For example, ordinary glass is transparent (high τ) to visible light but opaque in thermal infrared. So a pane of glass might transmit sunlight but act like an opaque gray body for the IR radiation from a heater. The exam usually sidesteps these complexities by treating materials as having one set of properties in the context of the problem.

Variations and related forms:

- **Opaque gray surface:** When $\tau = 0$ and $\varepsilon = \alpha$ (gray assumption), we get $\epsilon + \rho = 1$. This is a handy relation: if you know a surface's reflectivity, you immediately know its emissivity ($\varepsilon = 1 - \rho$). For instance, a metal with $\rho = 0.95$ (95% reflective) will have $\varepsilon \approx 0.05$ (5% emissive) in the infrared.

- **Absorbed vs. emitted energy:** Note that α refers to fraction of incoming **external** radiation absorbed. Emissivity ε refers to the fraction of energy (compared to a blackbody) that the surface itself **emits** due to its temperature. Under equilibrium, these are equal. On exam problems, if they give you α for a surface and it's opaque and gray, you can take that as ε for using Stefan–Boltzmann if needed.

- **Typical values:** Black, soot-covered surfaces: $\alpha \approx 0.95$ (and $\varepsilon \approx 0.95$). White or light-colored matte paint: maybe $\alpha \sim 0.2$–0.5 in visible, but still $\varepsilon \sim 0.9$ in IR (paints often emit IR well even if they reflect visible light). Polished metals: α (and ε) can be extremely low in IR, ~0.05. The exam won't make you memorize numbers, but qualitatively: **darker = higher ε**, **shinier = lower ε**.

- **Surface coatings:** Engineers sometimes apply high-emissivity coatings (black paint) to increase radiation loss or low-emissivity coatings (polished foil) to reduce it. An exam question might ask conceptually what happens to radiative heat loss if a surface is painted black versus left shiny – knowing these property differences will let you answer quickly (black paint increases ε and thus radiative heat loss).

Special notes: There's usually no heavy calculation needed purely for these definitions – they're concept questions or intermediate steps. If a problem gives you two of the three properties (α, ρ, τ), you can find the third by subtraction. Make sure to express percentages as fractions (e.g., 20% reflectivity → $\rho = 0.20$). And if you're asked to compare surfaces, frame your thinking like:

"Surface A has higher emissivity than surface B, so at the same temperature, A radiates more heat."

Explanation & analysis:

Explanation (tying it together): This topic is about recognizing what type of surface you're dealing with and how it will behave in radiation problems. On the FE, you might get a qualitative question like "Which surface emits more radiation: a blackbody or a white painted surface at the same temperature?" (Answer: the blackbody, because ε is higher). Or you might need to use given information: e.g. "a surface has reflectivity 0.7, find its emissivity assuming it's opaque" – you'd do $\varepsilon = 1 - 0.7 = 0.3$ (30%). The concept of black vs. gray vs. white also helps you know when you can simplify a problem: if something is stated to be a blackbody, you set $\varepsilon = 1$ and $\alpha = 1$; if a surface is highly reflective, you expect ε to be small, etc.

Analysis (breakdown and everyday examples):

- **Blackbody (α=1, ε=1):** Think of this as a surface that is "all business" with radiation – it soaks up everything and radiates the maximum possible. In practice, no material is a perfect blackbody, but surfaces like lamp black or carbon black come close. In exam terms, if they call something a blackbody, calculations get easier (ε=1 in Stefan–Boltzmann, no reflection to worry about).

- **White/refective surface (ρ high, ε low):** A shiny foil or white metal roof reflects most of the heat away. This is why thermal insulation blankets are shiny: to reflect radiation. For you, that means such a surface, if hot, doesn't radiate much heat out (low ε). If it's cool and exposed to heat, it doesn't absorb much either (low α). An everyday example: **wearing a white shirt on a sunny day** keeps you cooler than a black shirt because the white fabric reflects more sunlight (higher ρ, lower α), absorbing less heat. The same principle means that white or reflective coatings are used to keep equipment from heating up in the sun.

- **Gray surface ($0 < \varepsilon < 1$):** Most real objects fall here – they absorb and emit some fraction. The term "gray" just means we assume their ε is the same for all relevant radiation. You don't usually need to identify something as "gray" explicitly on the exam; rather, it's the default assumption unless told otherwise. What's important is to use the given emissivity or absorptivity values correctly. For instance, if a problem says "a gray body with emissivity 0.7," you apply $\varepsilon = 0.7$ in Stefan–Boltzmann, and you know it means it would absorb 70% of radiation incident on it as well.

- **Putting numbers to use:** If a surface has $\rho = 0.4$ (40% reflectance) and is opaque, then $\alpha = 0.6$ (60% absorbed). By gray body assumption, $\varepsilon \approx 0.6$ too. So at a given temperature, it emits 60% of what a blackbody would. That could be a quick intermediate calculation in a radiation heat transfer problem. Always double-check: does it make sense that if it reflects 40%, it absorbs 60%? Yes, and thus it should emit at 60% efficiency.

- **Avoiding pitfalls:** Many mistakes in this area come from misidentifying what the numbers mean. If a problem gives an emissivity, you don't need to worry about reflectivity explicitly (it's indirectly set). If it gives reflectivity for an opaque surface, you can find emissivity by subtraction. And if something is called "diffuse and gray," it's just telling you that using the single ε value is valid and you don't have to overthink wavelength details.

In summary, categorize the surface: *blackbody-like (high ε/α), gray (moderate ε/α), or reflective/white (low ε/α)*. Use $\alpha + \rho + \tau = 1$ to relate the properties if needed, and remember that for opaque materials, it simplifies to $\alpha + \rho = 1$. These fundamentals will guide you in any radiation problem, whether it's calculating heat transfer or just comparing which object radiates or absorbs more.

Topic 04 - Transient Processes

What it is: *Transient heat transfer* deals with time-dependent temperature changes in objects. Unlike steady-state conditions (where temperatures don't change with time), transient processes capture how a body's temperature moves toward a new equilibrium. In the FE Mechanical Exam, this typically means analyzing how a solid object heats up or cools down over time when exposed to a fluid at a different temperature (think of a hot metal ball cooling in air, or a cold object dropped into warm water).

Why it matters: Transient heat transfer questions appear regularly on the FE Mechanical Exam to test your grasp of *thermal response*. You'll often need to decide if you can use a simplified "*lumped system*" approach or if a full spatial solution is needed. The good news: for most exam problems with small objects or high-conductivity materials, you can **treat the object as *uniform temperature*** internally – greatly simplifying the math. This topic gives you a quick method (based on an exponential decay formula) to compute temperatures or times without solving complex differential equations.

Typical question archetypes: You might be asked to **compute the object's temperature after a given time**, **determine how long it takes to reach a certain temperature**, or simply **check if the lumped-capacitance method is valid**. The key is recognizing when *internal temperature gradients* can be neglected. Once you confirm the lumped model applies (using the Biot number criterion), it's usually a matter of plugging values into the exponential temperature formula or the time constant formula and crunching numbers. Expect problems like *"A copper sphere (given ρ, c_p, k) initially at X °C is placed in an environment at Y °C with convective coefficient h. What is its temperature after t seconds?"* or *"Is the lumped capacitance assumption justified for this scenario?"*

K12.T04.S01 – Lumped-Capacitance Model for Transient Conduction

Principle (bullet overview):

- **Uniform internal temperature assumption:** The lumped-capacitance model assumes the object's interior stays at a *uniform temperature* at all times during heating/cooling. In other words, **no significant temperature gradients** exist inside the object – the only temperature difference is between the object as a whole and the surrounding fluid. This is a valid assumption when the object conducts heat internally *much faster* than it convects heat to the surroundings.

- **Biot number criterion (negligible internal resistance):** To check if an object can be treated as lumped, compute the **Biot number**:

$$\mathrm{Bi} = \frac{h\,L_c}{k},$$

where h is the convective heat transfer coefficient (W/(m²·K)), k is the object's thermal conductivity (W/(m·K)), and L_c is a *characteristic length* of the object. For most shapes, a convenient choice is $L_c = \frac{V}{A_s}$ (volume divided by surface area). A **small Biot number** means the object's interior conducts heat readily compared to the convective heat loss at the surface. A common rule of thumb is **if $\mathrm{Bi} < 0.1$, internal temperature gradients are negligible**. On the exam, if you find Bi < 0.1, you're safe to use the lumped model; if Bi is larger, the lumped assumption starts to break down (and you'd need more advanced methods beyond the FE scope). *Remember:* Biot is dimensionless – a pure number indicating the ratio of internal vs external thermal resistance.

- **First-order exponential response:** Under lumped conditions, the cooling or heating of the object follows a **first-order exponential law** (also known as Newton's law of cooling for convective systems). The temperature difference between the object and the environment decays exponentially over time. This gives a simple formula for the object's temperature $T(t)$ at time t. Essentially, the object behaves like a thermal "capacitor" discharging (or charging) through a thermal "resistor" (the convective surface resistance).

- **Energy balance basis:** The lumped model comes straight from an energy balance: the rate of heat loss from the object's surface by convection $q = hA_s\,(T - T_\infty)$ equals the rate of internal energy change $\rho V c_p \frac{dT}{dt}$ (with a minus sign if the object is cooling). This yields a simple ODE whose solution is the aforementioned exponential formula. No need to solve the ODE on exam day – the standard solution will be in your toolkit (or easily derivable if you remember the form).

Equation Passport – Lumped System Temperature Decay

- **Name & purpose: Lumped-Capacitance Exponential Formula** – predicts the temperature of a solid object over time as it **cools or heats** in a fluid, assuming negligible internal temperature gradients. It gives the **temperature $T(t)$ of the object at time t**, as it approaches the ambient temperature T_∞. Use this in the FE exam for quick transient calculations when $\mathrm{Bi} < 0.1$.

- **General Equation (cooling form):**

$$T(t) = T_\infty + (T_i - T_\infty)\,e^{-t/\tau}$$

This form assumes the object starts at T_i and the ambient (fluid) is at T_∞. The object's temperature exponentially *decays* from T_i toward T_∞. For **heating scenarios** (object initially colder than environment), it's often written as:

$$T(t) = T_i + (T_\infty - T_i)\left(1 - e^{-t/\tau}\right)$$

Both forms are algebraically equivalent – they ensure that at $t = 0$, $T(0) = T_i$, and as $t \to \infty$, $T(t) \to T_\infty$. Just choose the form that feels intuitive for the problem (the first form works for cooling *or* heating if you plug in T_i and T_∞ with the correct sign on the difference).

Variables and units:

- $T(t)$ – object's temperature at time t; **units:** K (or °C, °F, etc., but be consistent).

- T_i – object's initial temperature at $t = 0$; **units:** same as $T(t)$.

- T_∞ – ambient fluid temperature (the temperature the object approaches as $t \to \infty$); **units:** same as $T(t)$.

- t – time elapsed since start of transient; **units:** s (seconds) [if other time units are used, τ will correspondingly be in those units].

- τ – **thermal time constant** of the object (in seconds for SI units); more on τ in the next subtopic, but essentially τ is a property of the object and convective environment, defined as $\tau = \frac{\rho V c_p}{h A_s}$. It has units of time.

- **Assumptions & scope:**

- Applies when **internal conduction is very fast relative to external convection**, i.e. Bi < 0.1. This ensures a uniform internal temperature. If Bi is larger (say 0.2 or more), the formula becomes less accurate because different parts of the object will be at different temperatures (gradient within).

- Assumes **constant properties and constant convective conditions**: h is taken as constant over time and surface, and material properties ρ, c_p, k are constant (valid for small temperature ranges). Also assumes the ambient temperature T_∞ stays constant (classic Newton's cooling situation).

- The object is typically assumed to have **no internal heat generation** and no phase change during the process. The cooling/heating is solely due to convection at the surface.

- This is a **1st-order linear system** in time. There are no oscillatory or higher-order effects – the response is a smooth exponential approach to equilibrium. (If you see anything more complicated, the lumped model likely doesn't apply or something like radiation or multiple bodies might be involved, which is beyond this simple formula's scope.)

- **Limit checks (sanity tests):**

- At $t = 0$**:** $e^{-t/\tau} = e^0 = 1$. The formula gives $T(0) = T_\infty + (T_i - T_\infty) * 1 = T_i$. Good – at time zero, the object's temperature is indeed the initial temperature (no change instantaneously).

- As $t \to \infty$**:** $e^{-t/\tau} \to 0$. The formula approaches $T(\infty) = T_\infty + (T_i - T_\infty) * 0 = T_\infty$. As expected, after a very long time the object's temperature tends to the ambient temperature – it either fully cools down or heats up to match the surroundings.

- **If τ is very small** (e.g. huge h or tiny object): the exponent $-t/\tau$ decays extremely fast, meaning $T(t)$ will reach close to T_∞ in a short time. In the limiting case $\tau \to 0$, the object's temperature would jump almost immediately to ambient (which makes sense: extremely high convection or negligible mass = quick equilibration).

- **If τ is very large** (e.g. very large object or very insulating surface): $e^{-t/\tau} \approx 1$ for a long time, meaning $T(t) \approx T_i$ initially – the object hardly changes temperature in the short term. Essentially, a very large time constant means slow response, as expected.

- **Use vs. sibling equations:** Use this *lumped capacitance* formula **instead of** the full transient conduction solutions (which involve spatially varying temperature and complex series or charts) whenever the **Biot criterion is satisfied (Bi < 0.1)**. In other words, *when in doubt on the exam, check Biot first*. If Bi is small, you can confidently stick with this simple exponential model. If Bi were large (not likely in exam scenarios unless they want you to say "lumped not valid"), then you'd **not** use this formula; you'd have to consider position-dependent heat conduction (which typically requires the tabulated one-term approximation or numerical methods – likely beyond FE exam requirements, unless a qualitative question).

- **Common exam traps:**

- **Mixing up T_∞ and T_i:** Make sure you subtract *initial minus ambient* vs *ambient minus initial* in the correct place. A quick way to avoid confusion: The exponential term $e^{-t/\tau}$ multiplies the *initial temperature difference*. If the object is cooling (initial hotter), $T_i - T_\infty$ will be positive and exponential decays that difference. If heating (initial colder), $T_i - T_\infty$ is negative, and indeed the formula will show an increase toward T_∞. Alternatively, use the second form $T_i + (T_\infty - T_i)\left(1 - e^{-t/\tau}\right)$ which directly adds the change to the initial value – some find this intuitively safer for heating cases.

- **Unit consistency:** Watch your units for time t and the time constant τ. If τ is computed in seconds (using SI units), then t must be in seconds as well in the exponent $e^{-t/\tau}$. If the problem gives time in minutes, convert it or convert τ accordingly. The exponential's argument must be dimensionless. Similarly, ensure T_i and T_∞ are in the same units (K vs °C is fine in differences, but °F vs °C would need conversion to a common scale or careful use of differences).

- **Geometry mistakes in V or A_s:** If you have to compute $\tau = \rho V c_p/(hA_s)$ (maybe given dimensions of the object), be careful computing volume and surface area correctly. It's easy to, say, use diameter instead of radius in formulas or forget that a "surface area" includes all sides. For example, a sphere's $V = \frac{4}{3}\pi r^3$ and $A_s = 4\pi r^2$. A long cylinder's A_s would include the side area and possibly the ends if not insulated. A thin flat plate might have top and bottom surfaces contributing to A, etc. Any error in V or A will directly mess up τ and thus the temperature prediction. Double-check geometry calcs to avoid this trap.

- **Using lumped when it's not valid:** If the exam question subtly gives a scenario with a very low conductivity material or an object with a large temperature gradient internally, the correct approach might be to *not* use the lumped formula. They might be testing if you know to check Biot number. If Bi is borderline or >0.1, the safe answer might be that lumped capacitance is not applicable (or using a more approximate method). So don't blindly apply the formula without checking the criterion when the problem hints at significant internal resistance (e.g., a big object made of insulating material).

Exam Handbook Search Cues (Not affiliated with or endorsed by NCEES): *"lumped capacitance", "Biot number", "transient conduction equation", "Newton's law of cooling"*

Footnotes/Details:

- *Biot vs. Nusselt:* Don't confuse the Biot number (internal conduction vs external convection) with the Nusselt number (convective heat transfer enhancement at a surface). Biot uses material k of the *object* and characterizes *internal* gradient significance. Nusselt uses k of the *fluid* and characterizes convective coefficient in flow – a very different concept. For transient conduction problems, it's Biot that governs lumped validity.

- *Material thermal diffusivity:* A low Bi often corresponds to high thermal diffusivity ($\alpha = k/(\rho c_p)$) and/or small characteristic length. High diffusivity materials (metals) tend to equalize

temperature internally quickly, helping meet Bi < 0.1. Conversely, materials like wood or plastic (low k) or very thick objects might fail the criterion. Keep an eye on extreme cases.

- *Hidden assumption – geometry independence:* The exponential formula given works for any shape *as long as* you use the correct A_s and V for that shape. It doesn't explicitly show geometry, which is nice – you just bury the shape info in τ. However, the characteristic length $L_c = V/A_s$ effectively scales with size. If you double an object's linear size (keeping same material and shape), L_c doubles, Bi doubles (for same h), so a larger object is less likely to be lumped-valid. This aligns with intuition: very large objects tend to have internal gradients (e.g., a big roast in an oven will have a crust and a cold center – not lumped!).

Explanation (in plain words): The lumped-capacitance model is basically Newton's cooling law put into an integrated form. It tells us *"how does an object's temperature slide toward the ambient temperature over time?"* On the FE exam, you'll use it whenever you have a single object exchanging heat with its surroundings and you want a quick way to find its temperature after some time or the time required to hit a certain temperature. The underlying idea is simple: the larger the temperature difference, the faster heat is transferred (out or in), so as the object's temperature approaches ambient, the rate slows—leading to an exponential approach to equilibrium. This is analogous to how a charging capacitor voltage approaches its final value in electronics, or how a cup of coffee cools – rapid at first, then slower. When you see a question about *"transient heat transfer"*, think of this: **Is the object small/high-conductivity (lumped)? Yes -> use the exponential formula with the given parameters.** It's your go-to tool for first-order thermal transients.

Analysis (step-by-step use and each term's role): To solve a typical lumped transient problem, follow these steps (and understand each term's physical meaning):

1. **Check applicability – compute Biot number:** First, if not explicitly stated, calculate Bi $= \frac{hL_c}{k}$. Use the object's material k, find $L_c = V/A_s$ (or sometimes they'll directly give a "characteristic length"). If Bi < 0.1, proceed with lumped model. (If Bi > 0.1, be cautious: the exam might expect a qualitative answer or use of a chart – but most often, exam problems are set up so lumped *can* be used.)

2. **Find the time constant τ:** Use $\tau = \frac{\rho V c_p}{hA_s}$. This τ is the heart of the exponential: it tells you the time scale of the process. A small τ means the object reaches near-ambient quickly; a large τ means it's sluggish. We'll formally cover τ in the next subtopic, but you'll likely compute it as part of using the formula.

3. **Apply the exponential formula:** Plug in the initial temperature T_i, ambient temperature T_∞, and the time of interest t into $T(t) = T_\infty + (T_i - T_\infty)e^{-t/\tau}$. This will give you $T(t)$. If the question asks for temperature after some time, this is your answer (numerically compute it). If it asks for time to reach a certain temperature, you'll set $T(t)$ equal to that temperature and solve for t (usually by taking a natural log, since $e^{-t/\tau} = \frac{T(t)-T_\infty}{T_i-T_\infty}$ can be rearranged).

4. **Interpret each symbol physically:** $T_i - T_\infty$ is the initial temperature *difference* – the driving force at $t = 0$. The exponential $e^{-t/\tau}$ tells us what fraction of that initial difference remains after time t. For example, $e^{-t/\tau} = 0.5$ means the difference has halved. The ambient T_∞ is the asymptote – the temperature the object is approaching. Each parameter influences the outcome: a higher h (better cooling) makes τ smaller, so the exponential decays faster (faster cooling); a higher $\rho c_p V$ (more thermal inertia – heavy or high-heat-capacity object) makes τ larger, slowing the decay (slower cooling).

5. **Double-check units and sense:** After computing, ensure the temperature you got makes sense (it should be between T_i and T_∞, not outside that range). Also check if the time constant seems reasonable: e.g., if τ = 100 s and you're finding $T(10\text{ s})$, that's only a fraction of τ, so the object shouldn't have cooled too much yet – roughly $e^{-0.1} \approx 90\%$ of the difference still there. These qualitative checks can prevent silly mistakes like entering something wrong in the calculator.

K12.T04.S02 – Time Constant & Exponential Temperature Response (Lumped Systems)

Principle (bullet overview):

- **Thermal time constant τ:** The **time constant** τ is the key parameter in a lumped thermal system. It has units of time (seconds in SI) and represents how quickly the system responds. By definition for a lumped system, $\tau = \frac{\rho V c_p}{h A_s}$. This comes from balancing the thermal "mass" ($\rho V c_p$, which is the heat capacity of the object) against the surface's ability to transfer heat (characterized by hA_s). Intuitively, τ **is the time it takes for the object to achieve about 63.2% of the total temperature change** needed to reach ambient. (Why 63.2%? Because $1 - e^{-1} \approx 0.632$. After one time constant, the exponential $e^{-t/\tau}$ drops to 0.37, meaning 37% of the initial difference remains, so 63% has been eliminated.) Smaller τ means a faster response; larger τ means a slower response.

- **Exponential temperature response:** With the time constant defined, the object's temperature change follows an exponential curve. At $t = \tau$, as mentioned, the object is 63% of the way to equilibrium. At $t = 2\tau$, about 86% $(1 - e^{-2})$ of the way. At $t = 3\tau$, about 95% of the way. The process is asymptotic – it never truly "finishes" in theory, but practically beyond about 5τ (99+% change) the object is essentially at ambient temperature. This exponential behavior is a hallmark of first-order systems and is very testable on the FE exam (they might ask qualitative things like "after how many time constants is a system ~95% complete?" or just expect you to know that a *short time* relative to τ means little change, while a time of several τ means nearly full change).

- **Using τ for quick estimates:** Because exponential curves can be tricky, engineers love using the time-constant multiples as benchmarks. One time constant (~63% change) is a significant chunk; *five* time constants (~99% change) is "basically done". On the exam, if you calculate a τ of, say, 10 minutes for a cooling process, you immediately know that in ~10 minutes the object will be well over halfway cooled, in ~30 minutes it will be almost fully cooled (~95%), etc. This can guide elimination of unreasonable answers.

- **Factors affecting τ:** The formula $\tau = \frac{\rho V c_p}{hA_s}$ tells us what matters. High ρ or c_p (very dense or high-heat-capacity material) → large τ (slow to change temperature because it can "hold" a lot of heat). Large volume V (bigger object) → more thermal mass, so larger τ. High convective coefficient h or large surface area A_s (strong cooling ability) → smaller τ (faster change). This aligns with experience: a small metallic object (small V, large A, high k hence often high h due to being in air, etc.) cools quickly (small τ),

whereas a big piece of wood (large V, relatively low h if air, low k meaning lower h effectively, etc.) cools slowly (large τ).

- **Calculating and using τ on the FE:** You'll either be given properties to compute τ explicitly, or you might infer τ from given information. Once τ is known, you plug it into the exponential formula. Alternatively, if asked "how long to reach X temperature," you set up $(T(t) - T_\infty)/(T_i - T_\infty) = e^{-t/\tau}$ and solve for t. Taking natural logs: $t = -\tau \ln\left(\frac{T(t)-T_\infty}{T_i-T_\infty}\right)$. This is a straightforward calculation – just be careful with the log algebra and sign.

Equation Passport – Thermal Time Constant

- **Name & purpose: Thermal Time Constant (τ)** – characterizes the **speed of transient thermal response** for a lumped system. It's the one-value summary of an object's resistance to temperature change: a large τ means the object resists change (takes longer to heat/cool), while a small τ means it adjusts quickly to the environment. Use this to compute how fast the exponential in the lumped formula decays, or directly to estimate timescales for the process.

- **Definition (formula):**

$$\tau = \frac{\rho\, V\, c_p}{h\, A_s}$$

Here $\rho V c_p$ is the total heat capacity of the object (mass times specific heat, since $\rho V =$ mass), and hA_s is the convective conductance (heat transfer coefficient times surface area). Sometimes you'll see this product hA_s in the denominator referred to as a thermal "resistance" (in an analogy: $\tau = \frac{\text{thermal mass}}{\text{surface conductance}}$). The units check out: $\rho V c_p$ has units J/K (energy per temperature) and hA_s has units W/K (energy per time per temperature), so the ratio is in seconds (J/K divided by W/K = seconds).

- **Variables and units:**

- τ – time constant (s)
- ρ – density of the object (kg/m³ in SI)
- V – volume of the object (m³)
- c_p – specific heat capacity of the object [J/(kg·K)]
- h – convective heat transfer coefficient [W/(m²·K)]
- A_s – surface area of the object (m²)

(All in SI units here; if you use USCS units, τ will come out in whatever time unit corresponds to your h. For example, if h is given in BTU/(hr·ft²·°F), then τ will be in hours, since $\rho V c_p$ would be in BTU/°F and hA_s in BTU/(hr·°F).)

- **Assumptions & scope:**

- This formula assumes the convective conditions are constant and the properties ρ, c_p don't change with temperature (linear system). It's derived under the same lumped-system assumptions as before. If those hold, τ remains constant over the process.

- Valid for times from 0 to a few multiples of τ. Beyond that, as mentioned, the object is nearly at ambient. On the exam, usually you won't deal with times > a few τ because changes beyond say 3–5τ are negligible (or the question will simply consider it "fully cooled").

- We *do not* use τ in cases of significant internal gradients (because then each part of the object could have its own local time scale). So τ as a concept really shines when Bi < 0.1.

- **Limit behavior:**

- If $h \to 0$ (extremely poor convection, like an almost insulated surface): $\tau \to \infty$. The object would take *infinitely long* to reach ambient – effectively it never really cools because there's almost no heat leaving. Of course, in reality h can't be zero, but this tells you that as convection gets weaker, the time constant blows up (very slow cooling).

- If $\rho V c_p$ is very small (tiny mass or low heat capacity, e.g. a foam ball or a small thermocouple bead): $\tau \to 0$. The system responds almost instantly to temperature changes because it has little ability to "hold" heat. That's why tiny thermometers adjust faster than big thermal mass objects.

- **Linear scaling:** If you double the mass (while keeping shape and material same, so V doubles and A_s doubles if it's a similar shape scaled up), what happens to τ? $\tau = \rho c_p \frac{V}{hA_s}$. For similar geometry scaled, $V/A_s =$ constant length/6 or something? Actually for similar shapes $V \propto L^3, A_s \propto L^2$, so $V/A_s \propto L$. Doubling linear size doubles L_c, thus doubles τ. This means bigger objects (of same material) have proportionally bigger time constants – not a surprise. Conversely, very small objects (like dust or droplets) have tiny τ and equilibrate almost instantly.

- **Common exam uses:** Typically, you'll calculate τ either explicitly or as part of the exponential formula. A common use-case: *"Compute how long (t) until the object reaches X°C"*. You'd solve $T(t)$ formula for t, which basically will involve τln of something. Knowing τ helps because you can sanity-check the answer (e.g. if $\tau = 50$s and they want time for 90% cooling, you expect on the order of τln(something) ≈ maybe 100+ s, since 90% is ~ 2.3τ because $e^{-2.3}$ 0.1).

- **Calculator tip (special notes):** All FE-approved calculators can handle the exponential and logarithm for these calculations. For example, on a TI-36X Pro, you'd use the ln key to solve for time: enter the fraction $(T(t) - T_\infty)/(T_i - T_\infty)$, hit ln, then multiply by $-\tau$. Or if computing $T(t)$, use the exp function or the e^x feature (on many calculators, that's second function of the ln key). **Be careful with parentheses:** when evaluating $e^{-t/\tau}$, it's wise to compute $(-t/\tau)$ first or ensure it's enclosed so that the negative sign and division are handled correctly. A common mistake is to type something like e^-5/10 meaning $e^{-5}/10$ to the calculator, which is wrong – you meant $e^{-0.5}$! So instead do exp(-5/10) or exp(-0.5). Double-check the order of operations if you're not fully comfortable with your calculator's syntax.

- **Common exam traps:**

- **Forgetting that τ is problem-specific:** If the exam throws multiple scenarios at you (say, the same object in air vs in water), remember that τ will change if h or other properties change. For instance, cooling the same hot metal in water (high h) yields a much smaller τ than cooling it in air (low h). Don't use a τ from one situation in another without recalculating.

- **Mismatched units in τ formula:** Ensure consistency: if ρ is in kg/m³, V in m³, c_p in J/(kg·K), h in W/(m²·K), and A_s in m², then τ comes out in seconds. If using non-SI, convert or be mindful: e.g., ρ in lbm/ft³, c_p in BTU/(lbm·°F), h in BTU/(hr·ft²·°F), you can still plug in – but the result for τ will be in hours (because effectively you have BTU/°F in numerator and BTU/(hr·°F) in denom). It's okay to work in those units, just interpret τ correctly as hours in that case, or convert to seconds by converting h to per second. Many

mistakes come from mixing hr and s or forgetting to convert minutes to seconds.

- **Interpreting the question wrong:** If asked for *"the time constant of the process"*, they literally want the value of τ (a number with time units). If asked *"after a time equal to two time constants, what is the temperature?"*, you plug $t = 2\tau$ in the formula (so $T(2\tau) = T_\infty + (T_i - T_\infty)e^{-2}$). If asked *"how long until the object is 99% of the way to ambient?"*, you set $(T(t) - T_\infty)/(T_i - T_\infty) = 0.01$ (since 99% to ambient means only 1% difference left) and solve $e^{-t/\tau} = 0.01$ giving $t \approx 4.605\tau$. These are the kinds of ways τ might be involved in questions – make sure to practice interpreting such phrasing.

Exam Handbook Search Cues (Not affiliated with or endorsed by NCEES): *"time constant", "Newton's cooling", "transient heat (lumped)", "exponential temperature"*

Footnotes/Additional insights:

- *Connection to circuits:* If you have an electrical engineering background, the $\tau = \frac{\rho V c_p}{hA}$ equation is analogous to RC (resistance-capacitance) time constant in a first-order circuit. $\rho V c_p$ is like a capacitance (stores thermal energy instead of charge), and $1/(hA)$ is like a resistance (impedes heat flow instead of electric current). The math form is identical. This can help memory: just as a capacitor charges to ~63% in one RC time constant, a thermal mass "charges" to 63% of the temperature difference in one τ.

- *Typical values:* For a small metallic object in air, τ might be on the order of seconds or minutes. For a large concrete structure, τ could be hours. The exam usually sticks to manageable scales – they won't have you compute something astronomical. But qualitatively, know that metals (high k) in fluids (decent h) → small τ; insulators (low k) or poor convection → large τ.

- *Beyond lumped (FYI):* If Bi > 0.1, each point in the object has its own local time response, and one must solve partial differential equations or use charts. The FE exam **generally avoids** requiring those heavy calculations – they expect you to either apply the lumped method or simply recognize that a non-lumped scenario cannot be solved with the given info (answer might then be conceptual).

- *Back-calculating h or c_p:* Occasionally a question might give experimental data (e.g. "object cools from X to Y in Z seconds") and ask to find an unknown like h or c_p. In such cases, you'd use the exponential law: plug in T(t) at that time, solve for the unknown inside τ. It's just algebra once you set it up. Keep an eye on whether they provide enough data to do this – typically one data point plus initial and ambient is enough to determine τ, and hence determine a single unknown parameter in τ.

Explanation (plain language): The time constant τ is essentially *"how long does it take to mostly finish this cooling/heating process?"* It's a very intuitive quantity once you get it: in one τ, you're over halfway there; in about 3τ, you're almost done. On exam day, if you can compute τ quickly, it gives you a feel for the problem. For example, if τ = 5 minutes and the question asks for the temperature after 5 minutes, you immediately know "Ah, one time constant, so answer should be about 63% of the way from initial to final temperature." That can help you eliminate options that are way off. Or if they ask how long to reach 90% of the temperature change, you know it'll be a bit more than 2τ (since 2τ is 86%). This kind of qualitative reasoning can check your math or even help you pick the right multiple-choice answer without full calculation if needed. In summary, τ distills the object's geometry, material, and convective environment into one parameter that tells you everything about the speed of the transient.

Analysis (term-by-term insight and common pitfalls): Looking at $\tau = \frac{\rho V c_p}{hA_s}$: each part has a real-world meaning.

- $\rho V c_p$ – this is the **thermal mass** (or heat capacity) of the object. It's how much heat energy (Joules) it takes to raise the object by one degree K. A larger thermal mass means the object is "harder to heat or cool" (like a heavyweight). So if $\rho V c_p$ is big, expect a long time constant. *Pitfall:* sometimes c_p might be given per unit mass, so remember to multiply by mass (or ρV) to get total heat capacity. Don't accidentally use just c_p (J/kg·K) without the mass.

- hA_s – this is the **thermal conductance to the environment**. It tells how easily heat can flow out/in. A_s is straightforward – more surface area, more pathways for heat to leave (think fins). h is trickier – it depends on the fluid and flow conditions (it might be given, or you use typical values: e.g. free convection air might be ~5–10 W/m²K, forced convection air 20–100, water can be 100–1000, etc.). A larger hA_s means the object "dumps heat" quickly (small τ). *Pitfall:* not using the correct surface area for convection – e.g. if one side is insulated or not exposed to fluid, that part of A_s shouldn't count. Use only the area actually in contact with the convecting fluid.

- Combining them, $\frac{\rho V c_p}{hA_s}$ makes sense: if either the numerator grows or the denominator shrinks, τ increases (slower response). If numerator shrinks or denominator grows, τ decreases (faster response). This symmetry can be tested: say they ask "what happens to the time constant if we cut the object's radius in half?" Smaller radius → volume scales down by 1/8, area by 1/4 for a sphere. Plug in: $\tau_{new} = \rho(V/8)c_p/\big(h(A/4)\big) = [(1/8)/(1/4)]\,\rho V c_p/(hA) = (1/2)\,\tau_{old}$. So, halving the size halved the time constant – it cools twice as fast. You can do these proportional reasonings to double-check understanding (and maybe answer conceptual questions). - When using τ in calculations, a **common mistake** is algebraic: solving $(T(t) = T_\infty + (T_i - T_\infty)e^{-t/\tau}$ for t. Students sometimes rearrange incorrectly. The safe way: isolate the exponential part first. E.g., $T(t) - T_\infty = (T_i - T_\infty)e^{-t/\tau}$. Then $\frac{T(t)-T_\infty}{T_i-T_\infty} = e^{-t/\tau}$. Then take natural log: $\ln\left(\frac{T(t)-T_\infty}{T_i-T_\infty}\right) = -\frac{t}{\tau}$. Finally $t = -\tau\ln\left(\frac{T(t)-T_\infty}{T_i-T_\infty}\right)$. The negative sign tends to trip people – notice that since $\frac{T(t)-T_\infty}{T_i-T_\infty} < 1$ for a cooling/heating scenario (the numerator is a smaller remaining difference), the log will be negative, and the negative sign in front of τ will yield a positive time t. This is as it should be (time is positive!). If you drop that negative inadvertently, you might get a negative time which makes no physical sense. So be mindful solving for time.

- Finally, ensure you report time in a reasonable unit as asked. If τ was 500 s (~8.33 min) and you compute t, the answer might be nicer in minutes or hours depending on context. The exam might not care about the unit as long as it's correct, but read the question – sometimes they'll specify "in seconds" or "in minutes." Give the answer in the requested unit to avoid losing points on a technicality.

Topic 05 - Heat Exchangers

Heat exchangers transfer heat between two fluids while keeping the fluids separate (so they do not mix). They show up everywhere in mechanical engineering – from radiators and air conditioners to power plant boilers and condensers. On the **FE Mechanical Exam**, you'll likely face questions asking you to **calculate heat transfer rates or outlet temperatures** for given inlet conditions, or to **identify the best heat exchanger configuration** for a scenario. Mastering this topic means knowing how different flow arrangements affect performance and being comfortable with the two main analysis methods: the **Log Mean Temperature Difference (LMTD)** method and the **Effectiveness–NTU** method. These tools let you determine how much heat is transferred, even when not all outlet temperatures are known. In short, heat exchangers combine principles of energy balance, convection, and conduction – and the exam will test your ability to apply these principles quickly and correctly.

K12.T05.S01 – Types of Heat Exchangers (Parallel, Counterflow, Cross-flow, Shell-and-Tube)

Parallel-Flow Heat Exchanger: Both fluids enter at the same end and move in the same direction. The temperature difference is greatest at the inlet and then steadily decreases as the two stream temperatures move closer together toward the outlet. Parallel flow is easy to recognize: the two fluid streams are side by side, entering together. However, it's **less efficient** at transferring heat than counterflow – in parallel flow, the cold fluid's exit temperature cannot rise above the hot fluid's exit temperature, and in practice both streams typically leave at temperatures closer to an intermediate value.

Counterflow Heat Exchanger: The two fluids enter at opposite ends and flow in opposite directions. This setup keeps the temperature difference between them higher and more uniform along the exchanger, which generally improves heat-transfer effectiveness. A counterflow exchanger can heat the cold outlet **almost up to** the hot fluid's inlet temperature (in the ideal limit of infinite area, it could approach it). It's the most thermodynamically efficient flow arrangement because the hottest part of one fluid is always next to the hottest part of the other, and likewise the coldest with coldest, maximizing driving temperature difference throughout.

Cross-Flow Heat Exchanger: The fluids move **perpendicularly (90°)** to each other – for example, one fluid might flow through tubes while the other flows across those tubes. Cross-flow designs are common when one fluid is a gas (like air flowing across a radiator's tubes). Performance falls between parallel and counterflow: efficiency depends on whether the fluids are "mixed" or not. If one fluid is free to mix as it flows (e.g. air moving through fins can mix in the transverse direction), its temperature becomes more uniform and heat transfer is a bit less effective. If both fluids remain unmixed in their own flow paths, the performance improves. Cross-flow units are often compact and used when space or geometry dictates the perpendicular arrangement.

Shell-and-Tube Heat Exchanger: This is a **specific construction** (very common in industry) rather than a flow direction per se. One fluid flows inside an array of tubes, while the other fluid flows outside those tubes but inside an outer shell. Baffles in the shell direct the flow across the tube bundle in a somewhat cross-flow manner, and multiple passes can be arranged (the tube fluid might flow back and forth through multiple tube passes, and shell flow can be arranged in 1, 2, or more passes). Shell-and-tube exchangers are typically analyzed as a series of simpler flow patterns (often approximated by an equivalent counterflow or cross-flow with a correction factor). For the FE exam, **basic identification** is key: know that shell-and-tube has a bundle of tubes (tube side) and a shell side – it's usually used for large-scale heat transfer (like condensers, evaporators) and can accommodate high pressures on the tube side.

Exam Handbook Search Cues (Not affiliated with or endorsed by NCEES): *heat exchanger*, *parallel flow*, *counterflow*, *cross-flow*, *shell and tube*, *flow configuration*

Footnotes:

- *Energy balance:* In any heat exchanger (assuming no leaks or external heat loss), the heat lost by the hot fluid = heat gained by the cold fluid. Mathematically: $m_h c_{p,h}\left(T_{h,in} - T_{h,out}\right) = m_c c_{p,c}\left(T_{c,out} - T_{c,in}\right)$. This fundamental balance often lets you find an unknown outlet temperature if the other outlet is known. Remember that one side's temperature drop is the other side's gain.

- *Performance intuition:* Counterflow is always **more effective** than parallel flow given the same inlet conditions and size – it can achieve a higher temperature change in the fluid with the smaller heat capacity rate. Parallel flow is inherently limited: even with an extremely large exchanger, a parallel-flow cold outlet can only approach the hot outlet temperature (not the hot inlet). In contrast, in **counterflow** the cold fluid's outlet temperature can **come close to the hot fluid's inlet temperature** as the exchanger size (or effectiveness) increases.

- *Fouling:* Real heat exchangers accumulate deposits (scale, sediment) over time that resist heat transfer (called **fouling**). Fouling adds a thermal resistance and **reduces performance**. On the exam, if you see a "fouling factor," it means the overall heat transfer coefficient U will be lower than in a clean unit. Usually, you'd add an extra resistance term in calculations (more on that in the LMTD section). If not mentioned, assume clean surfaces.

Variations and Related Forms:

- *Double-Pipe Exchanger:* A simple design with one pipe inside another (the inner pipe carries one fluid, the annulus carries the other). This can be run in parallel flow or counterflow. It's essentially the simplest form of a shell-and-tube (one tube, one shell). It's often used for small-scale duties or when a cheap, modular solution is needed. **On the exam, a double-pipe in counterflow is the go-to example** of an efficient heat exchanger.

- *Multi-Pass and Cross-Flow Exchangers:* When a shell-and-tube has multiple passes or a cross-flow pattern, the temperature distribution is more complex. We often handle this by applying a **correction factor** F to the LMTD method (discussed later). The correction factor adjusts the ideal counterflow/parallel flow log-mean ΔT for the efficiency loss due to the flow arrangement. Typical F values might be around 0.8–0.95 for common multi-pass setups – meaning the effective ΔT is a bit lower than pure counterflow.

- *Typical U-Values:* Different applications yield very different overall heat transfer coefficients U. For example, **liquid-to-liquid** (e.g. water to oil) in a shell-and-tube might have U on the order of a few hundred **W/(m²·K)**, whereas **gas-to-gas** exchangers (where convection is weaker on both sides) might have U in the tens of W/(m²·K). If one side involves boiling or condensation (phase change), U can be very high (because phase change can transfer heat rapidly at nearly constant temperature). While you won't need to memorize numbers, be aware that U depends on the convective performance of both fluids and the thermal conductivity of any wall between – it's essentially an aggregate measure of heat transfer ability.

Special Notes: In exam problems, **identify the configuration** from the description or figure. *Example:* "Fluid A enters at one end of a tube and fluid B enters at the opposite end in a concentric tube exchanger" – that's counterflow. If both enter the same end, it's parallel flow. Knowing this is crucial before applying any formulas. Also, remember that temperatures in a physical heat exchanger will always lie between the hottest and coldest inlet temperatures (neglecting exotic cases like phase change). So if you ever calculate a cold outlet that's hotter than the hot fluid's inlet, or a hot outlet colder than the cold inlet, **something is wrong** – check your work for mix-ups.

Explanation & Analysis: In a nutshell, the **flow arrangement** dictates how efficiently heat is transferred. Counterflow maintains a high temperature difference throughout because the hottest fluid meets the hottest portion of the other fluid, and the coldest meets the coldest. Parallel flow starts off with a bang (largest ΔT at inlet) but that ΔT quickly dwindles as the fluids travel together, so it doesn't use the full potential difference effectively. Cross-flow is a mixed bag – effectiveness depends on mixing, but it's often used where one fluid (like air) can't practically be run in counterflow tubes. Shell-and-tube is a practical engineering design that often approximates counterflow behavior by using multiple passes; it's the workhorse of industry for good reason (robust and scalable).

From an exam perspective, **types of heat exchangers** questions might be conceptual (like "which configuration yields the highest outlet temperature for the cold fluid given the same overall conditions?" – answer: counterflow). Or they might set the stage for a calculation by telling you the setup (so you know which formula or method to use). Always translate the problem statement into one of these categories: parallel, counter, cross, or shell-and-tube (which usually implies use of an F factor or an effectiveness given charts, depending on data). This classification is your *first move* before crunching numbers – it tells you how to approach the problem.

(Micro-check: True or False – For two fluids with equal heat capacity rates exchanging heat, a parallel-flow heat exchanger can achieve 100% heat transfer effectiveness if it is long enough. False. With equal capacity rates, parallel flow maxes out at 50% effectiveness even as length → ∞, whereas counterflow can approach 100%.)

K12.T05.S02 – Log Mean Temperature Difference (LMTD) Method for Heat Exchanger Analysis

Core Idea: The LMTD method computes heat transfer using an **averaged driving temperature difference** between the two fluids. Since the hot–cold temperature difference changes from inlet to outlet along the exchanger, we use the log-mean temperature difference as an appropriate average. This method is most straightforward when you **know both inlet and outlet temperatures** (or can determine them via energy balance). It gives a direct way to calculate the heat transfer rate Q (or required surface area A) if you know the overall heat transfer coefficient U.

When to Use: Apply LMTD when the problem provides (or you can find) the outlet temperature of at least one fluid (so that all four terminal temperatures are known: $T_{h,in}, T_{h,out}, T_{c,in}, T_{c,out}$). It's commonly used in **design problems** – e.g. "find the area needed for a heat exchanger to achieve a certain outlet temperature" or **analysis problems** with complete data – e.g. "what is the heat duty given this configuration and these inlet/outlet temps?".

Log-Mean Temperature Difference: This is defined as a particular average of the hot–cold temperature difference evaluated at the two ends of the exchanger. If ΔT_1 is the temperature difference at one end and ΔT_2 is the difference at the other end, **LMTD** = $\frac{\Delta T_1 - \Delta T_2}{\ln(\Delta T_1/\Delta T_2)}$. It's called "log-mean" because of the logarithm in that formula – it effectively comes from integrating the exponential temperature profile along the length.

Parallel vs. Counter in LMTD: The formula above is generic, but you must plug in the correct ΔT's for your configuration. For **counterflow**: $\Delta T_1 = T_{h,in} - T_{c,out}$ (hot inlet minus cold outlet) and $\Delta T_2 = T_{h,out} - T_{c,in}$. For **parallel flow**: $\Delta T_1 = T_{h,in} - T_{c,in}$ (initial difference at the inlet end where both enter together) and $\Delta T_2 = T_{h,out} - T_{c,out}$ (difference at the outlet end). Generally, counterflow yields a larger LMTD than parallel for the same terminal temperatures, which means more effective heat exchange.

Units & Consistency: The LMTD is a temperature difference, typically in **K** or **°C** (both work since it's a difference). U (overall heat transfer coefficient) might be given in W/(m²·K) (SI units) or in BTU/(h·ft²·°F) (US units). Be careful to use a consistent set of units: if you work in SI, Q comes out in watts, if in US customary, Q will be in BTU/hr. The beauty of using ΔT in °C or K (or °F vs °R) is that a difference of 1 K = 1 °C, and 1 °R = 1 °F, so you can plug differences in without converting between those (just **don't mix** one fluid in °C and the other in K – use the same unit for both fluids' temperatures when computing ΔT).

Equation Passport – LMTD Heat Exchanger Equation (Heat Duty via LMTD):

- **Name and purpose: Heat Exchanger LMTD Equation** – it is used to compute the heat-transfer rate Q (or the required area A) of a heat exchanger using the overall heat-transfer coefficient, the surface area, and the log-mean temperature difference between the two fluids. Essentially, it determines how much heat is exchanged based on an averaged driving temperature difference.
- **Equation (standard form):**

$$Q = U A F \Delta T_{\mathrm{lm}},$$

where Q is the heat transfer rate from the hot fluid to the cold fluid.

- Variables and units:

- Q – heat transfer rate (Watts in SI, or BTU/hr in US units). This is the thermal power being transferred. - U – overall heat-transfer coefficient [W/(m²·K) in SI, or BTU/(hr·ft²·°F) in US]. This single coefficient incorporates all modes of heat transfer (convection on each side + conduction through the wall, plus any fouling) into one value, based on a specified area.

- A – heat transfer surface area. You'll use the area corresponding to how U is defined (often the outer surface area of tubes, or inner surface, or an average – the problem should clarify). Units: m² (SI) or ft² (US).

- F – **correction factor** for LMTD (dimensionless). $F = 1$ for true parallel or true counterflow in a single pass. $F < 1$ if the exchanger has a multi-pass or cross-flow arrangement. It adjusts the temperature difference to account for the fact the flow arrangement isn't purely counter or parallel. Exam problems might give a value for F or a chart; if nothing is mentioned, assume $F = 1$.

- ΔT_{lm} – log-mean temperature difference (in K or °C, or °F if using US units – it's a difference, so unit consistency is what matters). This is computed from the inlet/outlet temps of both fluids as described above.

- **Assumptions and scope:**

- Steady-state operation (temperatures and flows are steady, not changing with time).

- No phase change of either fluid over the section analyzed (if a fluid condenses or boils, the LMTD method can still apply in pieces, but you'd handle the phase change portion separately since temperature might remain constant during phase change).

- No heat loss to surroundings (all heat leaving one fluid enters the other fluid). - Constant U over the entire exchanger. (This assumes fluid properties, flow conditions, and any fouling are uniform enough that the heat transfer coefficient doesn't vary along the length.)

- The temperature difference uses the appropriate configuration (parallel vs counter) – using the wrong ΔT formula is out-of-scope/invalid.

- The LMTD formula implicitly comes from an exponential temperature profile (typical of a well-behaved convective exchanger). If $\Delta T_1 = \Delta T_2$, the formula mathematically would be 0/0 – in that special case, the LMTD is just that same ΔT (i.e. if the temperature difference is uniform along the length, use that value).

- **Limit tests (sanity checks):**

- If the temperature difference at one end is zero (say $\Delta T_2 \to 0$, meaning one fluid leaves at the same temperature as the other fluid enters), then ΔT_{lm} tends to $\Delta T_1/\ln(\Delta T_1/0)$. Since ln(very large) is large, the LMTD goes to zero. Physically, if one end has no temperature difference, it means the fluids have equilibrated – there's little driving force left, so Q should drop to 0, as the formula predicts. - If U or A is zero, clearly $Q = 0$ (no heat transfer coefficient or no area → no heat transfer).

- If we increase A to a huge value (very large exchanger area), Q increases but it's ultimately limited by how far the temperatures can go. In reality, Q can't exceed the total energy one fluid can give up (or the other can absorb). The LMTD method itself doesn't directly enforce this limit, so it's on us to recognize physically that one fluid will run out of heat if we oversize too much. (This is where the NTU method comes in to consider such limits.)

- For a given set of inlet/outlet temperatures, if you accidentally swap the values or use parallel vs counter incorrectly, you might get a negative or nonsense LMTD. Always expect $\Delta T_{\text{lm}} > 0$ (hot side is hotter than cold side throughout). If you compute a negative log or a negative ΔT, check your inputs.

- **Use vs. sibling equations:** Use the LMTD equation **instead of the Effectiveness–NTU method** when you have sufficient information about outlet temperatures. LMTD is often more direct in those cases. Conversely, use the NTU method when you **cannot** determine one or both outlet temperatures easily (for example, if both outlet temps are unknown). Think of LMTD as the go-to for a fully specified heat exchanger, and NTU as the tool for partially specified cases or design from performance specs.

- **Common exam traps: - Mixing up ΔT definitions:** Students sometimes plug inlet minus inlet for both ΔT_1 and ΔT_2 regardless of configuration. Remember, for counterflow the two ends involve one inlet and the opposite outlet; for parallel, it's inlet-inlet and outlet-outlet. Mark these clearly in a sketch before calculating.

- **Unit confusion with U:** If U is given in BTU/(hr·ft²·°F) and area in ft², the product $U \cdot A$ has units of BTU/hr per °F. Multiplying by ΔT (°F) yields BTU/hr for Q – which is fine. The same numerical ΔT in °C would give a different numerical result if you didn't convert U! Generally, stick to one system for the calculation. Also note that a temperature difference in K is identical in magnitude to °C, and °R identical to °F, which can be handy.

- **Forgetting the F factor:** If the problem hints at a multi-pass exchanger or gives an F value or asks for it, don't ignore it. Using $F = 1$ when it isn't appropriate will overestimate Q. A typical mistake is to apply the pure counterflow LMTD to a shell-and-tube with multiple passes without adjusting – this can introduce ~10–20% error easily.

- **Mismatched heat balance:** After computing Q with $U \cdot A \cdot \Delta T_{lm}$, it's good practice to double-check that the same Q doesn't demand impossible temperature changes in the fluids. For instance, use $Q = m_h c_{p,h}\left(T_{h,in} - T_{h,out}\right)$ and verify that $T_{h,out}$ is above $T_{c,in}$. If your LMTD calculation suggests the hot fluid would cool below the cold inlet temperature, something's off (likely an assumption violated or an error in arithmetic).

Exam Handbook Search Cues (Not affiliated with or endorsed by NCEES): *log mean temperature*, *LMTD*, *heat exchanger* $Q = UA\Delta T$, *overall heat transfer coefficient*, *correction factor F*

Footnotes:

- *Calculating U from individual resistances:* Occasionally, you may need to compute the overall heat transfer coefficient U from given convection coefficients and wall properties. Remember, **thermal resistances in series** add up like electrical resistances. For a simple tube wall: $\frac{1}{UA} = \frac{1}{h_h A_h} + \frac{\Delta x}{k A_{\text{wall}}} + \frac{1}{h_c A_c}$ (plus any fouling factors). Here h_h and h_c are hot and cold side convective coefficients, $\Delta x/k$ is the wall's conduction resistance (thickness over conductivity, and use area appropriately for cylindrical vs flat wall), and A_h, A_c are the areas on hot and cold sides. In many cases, the tube wall is thin or has high thermal conductivity, so the wall term is small compared to convection terms – then U is dominated by the smaller of h_h or h_c. A quick way to ballpark U is to take the **harmonic sum** of the convective coefficients: $1/U \approx 1/h_h + 1/h_c$ (if areas are equal and no fouling). Don't forget to include fouling resistances if given: they act just like extra wall resistances.

- *Sign Convention:* $Q = UA\Delta T_{lm}$ is typically the heat **transferred to the cold fluid** (and lost by the hot fluid). It doesn't much matter as long as you're consistent – just know that Q will be positive in the direction of heat flowing from hot to cold. If you apply the formula and get a negative Q, it usually means you swapped hot vs cold somewhere (or used a negative ΔT by accident).

- *Choosing reference area:* Problems might not always spell out whether U is based on the inner tube area, outer tube area, etc. If not stated, it's often safe to assume U is based on the **outer area of inner tubes** (common convention in shell-and-tube). However, the exam will likely provide enough info so that you don't have to guess – either by giving U and A together (so you just multiply) or by being explicit. If you ever had to derive U and areas differ, remember the formula links U on one area to the other: $U_{\text{inner}}A_{\text{inner}} = U_{\text{outer}}A_{\text{outer}}$ because the heat flow is the same through both. But again, that level of detail is usually beyond what's needed in a quick exam question.

- *Extreme case:* If $\Delta T_1 = \Delta T_2$, the LMTD formula's denominator becomes $\ln(1) = 0$. Mathematically, you'd do a limit which gives $\Delta T_{lm} = \Delta T_1$ in that case. Practically, this situation means the temperature difference is uniform – which usually implies one fluid has an extremely large heat capacity (so its temperature hardly changes). If you encounter this, it means one side isn't cooling/heating much at all. You can safely use the common ΔT for calculations, or better yet, recognize that if one fluid's temperature change is negligible, $Q = mc_p\Delta T$ for that fluid might be easier to compute directly.

Variations and Related Forms:

- *Rearranged forms:* The same equation can be solved for area or U. For instance, if asked "How large (area) must a heat exchanger be to achieve a certain Q?", you'd use $A = \frac{Q}{UF\Delta T_{lm}}$. Or, to find U given performance, $U = \frac{Q}{AF\Delta T_{lm}}$. Just keep track of F and ΔT_{lm} for the correct configuration.

- *Correction Factor F:* For multi-pass shell-and-tube or certain cross-flow exchangers, the exam might give you a graph or table of F vs. some parameters (like two temperature ratios) or might state a value. Using F is straightforward: calculate the LMTD as if it were pure counterflow (that usually gives the largest ΔT), then multiply by F (which is <1) to get the real effective ΔT. **Do not** apply F unless the problem indicates a need (i.e. mentions multi-pass, cross-flow, or directly gives F). If nothing suggests it, assume $F = 1$.

- *Typical values:* An LMTD might come out to, say, 20 K or 30 K in a well-designed exchanger. If you ever get an LMTD that is extremely small (like 1 K) in a problem, check if that makes sense: it would imply the two fluids are nearly in thermal equilibrium throughout – perhaps too efficient to be realistic for finite size. Conversely, an LMTD equal to the full difference between one side's inlet temps (say hot in minus cold in) usually means the other side hardly changed temperature (one fluid has a huge thermal capacity or the exchanger is tiny). These boundaries can guide you in judging if your results are reasonable.

Special Notes (Calculator Tips): When computing ΔT_{lm}, do it in steps to avoid algebra mistakes: 1. Compute the two end differences ΔT_1 and ΔT_2. 2. Take their ratio $\frac{\Delta T_1}{\Delta T_2}$ (make sure both differences are in the same unit, like K or °F). 3. Hit the natural log (ln) of that ratio. 4. Now subtract: $\Delta T_1 - \Delta T_2$. 5. Finally, divide: $(\Delta T_1 - \Delta T_2)/\ln(\Delta T_1/\Delta T_2)$.

This sequence minimizes rounding errors and ensures you don't accidentally take ln of a negative or something. Also, watch out for cases where $\Delta T_2 > \Delta T_1$ – that can happen in counterflow if the cold side gains a lot of heat. The log formula still works (you'd get a negative in both numerator and denominator, which cancel out), but double-check that you kept the sign consistent (the LMTD should be positive regardless of which side you call 1 or 2, as long as you're consistent). If using a TI-36X Pro or similar exam-approved calculator, you might store ΔT_1 and ΔT_2 in memory (e.g. STO) to reuse in the formula easily. Small arithmetic mistakes on LMTD can lead to big differences, so take care with the keystrokes!

Explanation & Analysis: The LMTD method is essentially an application of **Newton's cooling law integrated along the length** of the heat exchanger. Rather than dealing with a differential equation on the exam, you use this pre-derived formula that compresses all those details into a simple log-mean ΔT. Physically, what does ΔT_{lm} represent? It's an average temperature difference, weighted such that it accounts for the fact that temperature changes are exponential. If the temperature difference between fluids didn't change along the exchanger (like in an ideal infinite capacity fluid scenario), the LMTD would just equal that constant difference. If the difference drops a lot from one end to the other (like in parallel flow, where the hot cools down quickly and cold warms up quickly), the LMTD will be significantly smaller than the simple arithmetic average – reflecting the fact that a good chunk of the exchanger operates under a smaller driving force.

In using $Q = UA\Delta T_{lm}$, you're basically doing: Heat flow = (overall conductance) × (average driving force). Each part of the exchanger contributes, and U is like the "ease" of heat flow per area per degree of difference. Let's break down each term:

- U: Think of U as how **good the exchanger is at transferring heat per unit area**. A high U means heat zips from hot side to cold side easily (either because both fluids convect well and/or the wall between is thin and conductive). If either fluid is a poor conductor (like a gas with low h), or if you have a thick tube wall or fouling, U drops. In an exam context, if they supply U, they usually assume you'll use it directly. If they want you to combine convective and conductive resistances, they'll give you those values. Always identify the bottleneck: e.g., if one side is air (low h ~ 10 W/m²K) and the other is water (h ~ 500 W/m²K), you know the air side dominates the resistance, and $U \approx 10$ something (plus small extras).

- A: More area means more contact between fluids (through the wall), so more heat can be transferred. This is linear – double the area, double the Q (if all else stays same). On the exam, if asked to size an exchanger, you'll solve for A. If A comes out unreasonably large or small, that flags a possible input error. For instance, a required area of 10^{-3} m² to cool a power plant stream is way too small – you might have used °C when you should've used °F or messed up ΔT. Likewise, an area of 10^5 m² for a small heat duty is nonsensical – perhaps U was used in the wrong units.

- ΔT_{lm}: The star of the show. It encapsulates the combined effect of all four terminal temperatures. If the hot and cold fluids have **big temperature gaps on one end but not the other**, it tells you that the driving force isn't uniform, and it gives an equivalent uniform difference that would produce the same Q. In **counterflow**, typically ΔT_{lm} is larger because one end of the exchanger still has a decent temperature difference even as the other end narrows. In **parallel flow**, ΔT_{lm} is significantly smaller than the initial ΔT because by the outlet the fluids might be much closer in temperature. This mathematically explains why counterflow transfers more heat: it has a larger effective average ΔT for the same inlet/outlet conditions.

- F: If applicable, F simply scales the ΔT. Intuitively, a multi-pass shell-and-tube doesn't perform quite as well as a pure counterflow because parts of the flow might be more like parallel or cross-flow. F might be ~0.9, meaning you get 90% of the ideal counterflow

driving force. So Q ends up 90% of what you'd calculate with counterflow assumptions. Always read if an F is given or needed.

To solve LMTD problems: **(1)** Determine the flow arrangement (parallel, counter, etc.) and assign the correct temperatures to ΔT_1 and ΔT_2. **(2)** Compute ΔT_{lm}. **(3)** Plug into $Q = UAF\Delta T_{lm}$. **(4)** If any of Q, U, A is unknown, solve for it algebraically. **(5)** Cross-check with energy balances if needed (for example, use one fluid's $mc_p\Delta T$ to ensure that Q doesn't conflict with given or expected outlet temps). This structured approach will help you avoid mix-ups.

Remember, the LMTD method requires knowing or having a way to get all the terminal temperatures. If you find yourself with two unknown outlets and only inlet info, you can't directly use LMTD alone – that's the cue to switch to the **Effectiveness–NTU method**, which we'll cover next.

K12.T05.S03 – Effectiveness–NTU Method for Heat Exchangers

Core Idea: The Effectiveness–NTU method lets you analyze a heat exchanger even when both outlet temperatures are not known in advance. Instead of using actual temperatures directly, it uses dimensionless parameters: **effectiveness (ϵ)** – how well the exchanger performs relative to the maximum possible, and **Number of Transfer Units (NTU)** – a measure of the size or capacity of the exchanger relative to the flow rates. This method is especially useful for sizing problems or cases where you only know inlet conditions and the heat exchanger geometry, and you want to find outlet temperatures or heat transfer.

Effectiveness (ϵ) Definition:

$$\epsilon = \frac{\text{Actual heat transfer rate } (Q)}{\text{Maximum possible heat transfer rate } (Q_{\max})}$$

It's a fraction (0 to 1) that tells you how much of the potential heat exchange is achieved. $Q_{\max}$ is determined by the fluid with the **smaller heat capacity rate** – because that fluid will limit how much heat can be absorbed or released (once that fluid changes temperature as much as it possibly can, you've hit the max). In practice, $Q_{\max} = C_{\min}(T_{h,in} - T_{c,in})$, meaning the smallest heat capacity $C_{\min}$ times the biggest temperature difference initially available.

Number of Transfer Units (NTU):

$$\text{NTU} = \frac{UA}{C_{\min}}$$

This is a dimensionless parameter that represents how "large" the exchanger is relative to the flow capacity of the limiting fluid. A higher NTU means more surface area or better heat transfer (higher U) compared to the flow's ability to carry heat – essentially a bigger NTU indicates a more effective exchanger. For example, NTU = 1 might be a modest exchanger, NTU = 5 is very large (approaching full effectiveness for many configurations).

Heat Capacity Rates: Define $C = \dot{m}c_p$ for each fluid (with units of W/K or BTU/hr-°F). We label C_h for the hot fluid and C_c for the cold fluid. One of these will be $C_{\min}$ (the smaller one) and the other $C_{\max}$. The ratio $C_r = \frac{C_{\min}}{C_{\max}}$ is often used in the effectiveness formulas. It ranges from 0 to 1. Two notable cases: $C_r = 0$ means one fluid has an *infinitely large* capacity compared to the other (practically, one fluid's temperature doesn't change, like an infinite reservoir or a phase change at constant temp). $C_r = 1$ means both fluids have equal capacity rates (symmetrical case).

Using Effectiveness–NTU: Typically, you compute NTU (from known U, A, and flows) and determine C_r. Then, using the appropriate relation for the given exchanger type (parallel flow, counterflow, cross-flow, etc.), you find ϵ. Once you have ϵ, you get the actual heat transfer $Q = \epsilon\, Q_{\max}$. From that, you can back-calculate any unknown outlet temperature using the energy balance on either fluid. The exam might provide you with the effectiveness formulas or charts, so you don't have to memorize the complex ones – but you should know how to use them and the general trends (e.g., counterflow is more effective than parallel for the same NTU and C_r).

Equation Passport – Heat Exchanger Effectiveness–NTU Relations:

Name and purpose: Effectiveness–NTU Equations – determine the performance of a heat exchanger (what fraction of the maximum possible heat is actually transferred) using dimensionless parameters. They eliminate the need to guess outlet temperatures by providing a direct way to compute heat transfer from geometry and flow rates. Use these relations to find Q when outlet temps are unknown, or to size an exchanger to achieve a desired effectiveness.

Governing definitions/equations:

- *Effectiveness (general definition):*
  $\epsilon = \frac{Q_{\text{actual}}}{Q_{\max}}$,
  where $Q_{\max} = C_{\min}(T_{h,in} - T_{c,in})$.
- *Number of Transfer Units:*
  $\text{NTU} = \frac{UA}{C_{\min}}$.
- *Effectiveness–NTU functional relations:* These depend on the heat exchanger configuration:

  Parallel-Flow (both fluids same direction):

  $$\epsilon_{\text{parallel}} = \frac{1 - \exp[-\text{NTU}\,(1 + C_r)]}{1 + C_r},$$

  where $C_r = C_{\min}/C_{\max}$.

  Counterflow (fluids opposite directions):

  $$\epsilon_{\text{counter}} = \frac{1 - \exp[-\text{NTU}\,(1 - C_r)]}{1 - C_r \exp[-\text{NTU}\,(1 - C_r)]} \qquad (C_r \neq 1),$$

  and in the special case $C_r = 1$ (equal capacity rates), this formula indeterminately becomes $\epsilon = \frac{\text{NTU}}{1+\text{NTU}}$.

  Cross-Flow: If both fluids are unmixed (each flows in its own direction without mixing transverse to flow), the effectiveness can be estimated by:

$$\epsilon_{\text{cross, unmixed}} = 1 - \exp\left[-0.22\,(C_r^{-0.78})\left[\exp\left(-C_r\,\text{NTU}^{0.78}\right) - 1\right]\right]$$

(This is a curve-fit formula; often, **charts** are used instead of plugging such an expression.)
If one fluid is mixed (e.g. air mixing in a plenum), the effectiveness is a bit lower (the exact formula is different and typically given by charts or tables).

Shell-and-Tube (1 shell pass, 2 tube passes, etc.):
These often are analyzed as equivalent to a certain number of counterflow units or via charts. A 1–2 shell-and-tube (1 shell pass, 2 tube passes) has an effectiveness relation not easily expressed in a simple formula; exam problems will likely either simplify it or give you an effectiveness or F-factor rather than expecting derivation. Generally, shell-and-tube effectiveness falls between counterflow and parallel depending on the number of passes.

Variables and units:

- ϵ – effectiveness (dimensionless). $\epsilon = 0$ means no heat transfer (e.g. an infinitely short exchanger or perfect insulation between fluids), $\epsilon = 1$ means the exchanger is perfect (the limiting fluid changes temperature by the full possible range $T_{h,in} - T_{c,in}$). Real exchangers will have $0 < \epsilon < 1$ (usually well below 1).
- $Q_{\max}$ – maximum possible heat transfer (Watts or BTU/hr, same units as actual Q). It is calculated using $C_{\min}$ and the initial temperature difference. Essentially, it's the heat transfer you'd get if the fluid with smaller heat capacity were to be heated or cooled all the way to the inlet temperature of the other fluid.
- $C_{\min}, C_{\max}$ – the smaller and larger heat capacity rates (W/K or BTU/hr-°F). $C = \dot{m}c_p$ for each stream. The one with smaller mc_p is $C_{\min}$. It's this fluid that will experience the larger temperature change and will constrain $Q_{\max}$.
- C_r – capacity rate ratio = $C_{\min}/C_{\max}$ (dimensionless). This is always ≤ 1. If you see a problem where one fluid is described as "a large reservoir" or undergoes a phase change, you often take $C_r \approx 0$ because one side effectively can absorb or supply heat without significant temperature change.
- NTU – number of transfer units (dimensionless). We compute it from geometry and convection info: U [W/(m²·K)] times A [m²] gives a conductance (W/K), dividing by $C_{\min}$ (W/K) cancels to a pure number. Same logic in US units: if U is in BTU/(hr·ft²·°F), A in ft², and $C_{\min}$ in BTU/hr-°F, NTU is unitless. An NTU of 1 roughly means "the exchanger can absorb one unit of the smaller fluid's thermal capacity per unit time per degree difference" – not a super intuitive concept in words, but as a number, higher is always better for heat transfer.
- Temperature terms in the effectiveness formulas: $T_{h,in}, T_{c,in}$ etc. These are just the inlet temperatures (hot fluid inlet and cold fluid inlet). All effectiveness formulas are built on those initial conditions, which is why you don't need outlet temps beforehand.

Assumptions and scope:

- Same basic assumptions as LMTD: steady state, no external heat loss, no phase change (at least not without modification), and constant properties.
- The effectiveness–NTU formulas listed are for specific configurations (e.g., the parallel and counter ones above assume a single-pass uniform flow). For exam purposes, parallel and counterflow are the primary ones you might use numerically. Cross-flow and multi-pass would likely be handled via charts or given data rather than expecting derivation.
- $C_{\min}$ correctly identified – the method hinges on knowing which fluid is the limiting one. It's usually obvious: if one fluid has a much lower mass flow or lower c_p, that's $C_{\min}$. If you accidentally pick the wrong one, $Q_{\max}$ and thus ϵ calculations will be off (you might even get $\epsilon > 1$ which is unphysical).
- The NTU method inherently accounts for the fact that you can't transfer more heat than one fluid can carry – that's why it's powerful. It won't let you compute an impossible Q because if you try to push NTU → ∞, ϵ approaches a finite limit (<1 for most cases except when $C_r = 0$).
- The formulas assume *counterflow of the differential elements of fluid* in those configurations. For shell-and-tube with multiple passes or cross-flow, the derivation is more complex; provided formulas or charts circumvent that complexity.

Limit tests:

- **NTU → 0:** If an exchanger has essentially no area or no heat transfer capability (NTU very small), we expect no heat transfer. Check the formulas: for parallel,
$$\epsilon \approx \frac{1-e^{-NTU(1+C_r)}}{1+C_r} \approx \frac{1-(1-(1+C_r)NTU+\cdots)}{1+C_r} \approx \frac{(1+C_r)NTU}{1+C_r} = NTU$$
for small NTU. So $\epsilon \approx NTU$ (for small NTU, both parallel and counterflow actually give $\epsilon \approx NTU$ as well). So if NTU = 0, $\epsilon = 0$. That matches expectation: no area, no heat transfer.
- **NTU → ∞:** An infinitely large exchanger would maximize heat transfer. For **counterflow**, as NTU → ∞, $\epsilon_{\text{counter}} \to 1$ (especially if $C_r < 1$; if $C_r = 1$, plugging NTU → ∞ in $\frac{NTU}{1+NTU}$ gives 1 as well). This means counterflow can achieve virtually 100% of $Q_{\max}$ if you have enough surface – which makes sense, you can approach the other fluid's inlet temperature given a very large exchanger. For **parallel flow**, as NTU → ∞, $\epsilon_{\text{parallel}} \to \frac{1}{1+C_r}$. So if $C_r = 1$ (equal capacity), $\epsilon \to 1/2 = 50\%$. If one side has a much smaller capacity (say $C_r = 0.1$), then $\epsilon \to \frac{1}{1+0.1} \approx 0.91$. In other words, even an extremely large parallel-flow exchanger cannot transfer all the heat if the fluids have comparable capacities – they'll meet in the middle and have unused potential. This is a crucial difference: **counterflow can always do better or equal than parallel**, never worse.
- $C_r \to 0$**:** This means one fluid has an enormous capacity (acts like an infinite sink/source, or maybe it's condensing/boiling at constant temp). In that case, the limiting fluid is the other one. If $C_r = 0$, the formulas simplify. For both parallel and counterflow, ϵ tends to

$1 - e^{-\text{NTU}}$. (You can derive this: set $C_r = 0$ in the parallel formula: $\frac{1-e^{-NTU}}{1+0} = 1 - e^{-NTU}$. In counterflow: $\frac{1-e^{-NTU}}{1-0 \cdot e^{-NTU}} = 1 - e^{-NTU}$.) So interestingly, if one fluid is essentially unchanging in temperature, both parallel and counterflow have the *same effectiveness*. That's logical because if one side is an infinite reservoir, the flow arrangement doesn't matter – the finite fluid just sees a constant temperature bath either way.

- $C_r = 1$**:** Both fluids have equal capacity. We mentioned the asymptotes: parallel maxes at 50% effectiveness, counterflow can reach 100% in theory. At finite NTU, say NTU = 1 and $C_r = 1$: parallel $\epsilon = (1 - e^{-2})/2 \approx 0.432$; counterflow $\epsilon = NTU/(1 + NTU) = 1/2 = 0.5$. So counter is a bit better. At NTU=2: parallel $\epsilon \approx (1 - e^{-4})/2 = (1 - 0.0183)/2 \approx 0.490$; counter $\epsilon = 2/3 \approx 0.667$. The gap grows with NTU.

Use vs. sibling equations: Use the Effectiveness–NTU method **instead of LMTD** when you don't have enough temperature information or when a problem asks in a way like "given this size exchanger, what is the heat transfer?" or "how much can we cool this fluid with the other fluid's inlet temp known but outlet unknown?". It's particularly handy for **rating problems** (find performance of an existing exchanger) or **when asked for max possible heat transfer** (that's basically $Q_{\max}$, a concept from this method). If you *do* know all four end temperatures, the NTU method is overkill – you'd just use LMTD or simple energy balance. Also, if a question asks for the **"effectiveness"** explicitly, it's pointing you to use this method.

Common exam traps:

- **Mixing up which T goes where in $Q_{\max}$:** Use hot inlet minus cold inlet ($T_{h,in} - T_{c,in}$). Some might mistakenly use hot inlet minus cold outlet or something – but $Q_{\max}$ is based on the initial driving delta. It assumes the cold fluid could in theory reach $T_{h,in}$ (best case) or the hot fluid cool to $T_{c,in}$, whichever is the limiting scenario.
- **Wrong $C_{\min}$:** Identify $C_{\min}$ carefully. If, say, hot flow is 2 kg/s with $c_p = 1kJ/kgK$ ($C_h = 2000W/K$) and cold flow is 5 kg/s with $c_p = 4kJ/kgK$ ($C_c = 20000W/K$), then hot is the limiting stream ($C_{min} = 2000$, $C_r = 0.1$). It's easy to accidentally swap if not paying attention. A quick check: the fluid with smaller C will undergo the larger temperature change. If your calculation yields a cold fluid temperature drop bigger than the hot fluid cooling, but cold had the larger capacity, that's inconsistent.
- **Using the wrong effectiveness formula:** The exam might not expect you to memorize formulas, but if they do or if multiple choice answers are in terms of NTU and C_r, know which formula goes with which configuration. A classic mistake is to apply the simpler parallel flow formula to a counterflow situation (or vice versa). This can lead to big differences. If unsure, remember: **counterflow is more effective**, so for the same NTU and C_r, $\epsilon_{\text{counter}} > \epsilon_{\text{parallel}}$. If you accidentally plug into the wrong one and get a smaller number for what is actually a counterflow problem, that's a red flag.
- **Out-of-range results:** ϵ must be ≤ 1 (100%). If you calculate an effectiveness above 1, something is definitely wrong – likely $C_{\min}$ and $C_{\max}$ got swapped or an algebra error occurred. Also, ϵ being exactly 1 is only possible as NTU→∞ or C_r→0 idealization. If you get $\epsilon = 1$ in a finite problem, double-check if maybe one fluid was assumed infinite (C_r=0) and NTU is extremely large. Usually, exam problems are set up with moderate NTUs where ϵ comes out, say, 0.3 to 0.9.
- **Overlooking units in NTU:** While NTU is dimensionless, making it, say, NTU = 5 in SI is the same physical situation as NTU = 5 in US units *if all values were converted properly*. But you must use consistent units when computing NTU. For example, if U is in W/m²K and A in m², and $C_{\min}$ in J/s·K (which is W/K), you're fine. If you inadvertently mix W/m²K with ft² or something, you'll get a wildly off NTU. It's not common to present NTU in mixed units, but just be cautious to plug values in one coherent unit system.

Exam Handbook Search Cues (Not affiliated with or endorsed by NCEES): *heat exchanger effectiveness*, *NTU*, *Number of Transfer Units*, *effectiveness chart*, *capacity ratio*, C_{min}

Footnotes:

- *Relation to LMTD:* The NTU method and LMTD method are two sides of the same coin. In fact, if you have both fluids' inlet/outlet temps, you can compute an NTU from that data and vice versa. But for exam use, treat them separately: LMTD for known temps, NTU for unknown temps. It's good to know that at **low NTU (<1)**, both parallel and counterflow exchangers have similar performance (not much surface, so not much heat transferred). At **high NTU**, counterflow clearly outperforms. This trend could be a conceptual question (e.g., "which configuration yields the highest heat transfer for a given large NTU?").

- *Working with charts:* If given an effectiveness vs NTU chart, you'd find the curve for the appropriate C_r and flow arrangement, then read ϵ at the given NTU. The process on the exam: calculate NTU, determine C_r, and go to the chart. Since reading a chart is an approximation, the exam likely gives either a straightforward formula or nice round values so that the answer is clear without fine interpolation. Practice reading quickly: identify parallel vs counter curves (counter usually yields higher ϵ for the same NTU).

- *Combining with energy balance:* Once ϵ gives you Q, don't forget to use the basic heat balance to get outlet temps if asked. For instance, if asked "What is the outlet temperature of the cold fluid?", you'd first find $Q = \epsilon C_{\min}(T_{h,in} - T_{c,in})$. Then use $Q = m_c c_{p,c}(T_{c,out} - T_{c,in})$ (assuming the cold fluid is the one with C_{min}, it will experience the full effect) to solve for $T_{c,out}$. Alternatively, if the hot fluid was C_{min}, you'd use its energy balance. A common mistake is to compute Q and give that as the answer when the question actually wanted the temperature – so be careful to answer what's asked.

- *No phase change assumption:* The standard effectiveness formulas assume the specific heats are constant and no phase change. If a fluid condenses or boils in the exchanger, the problem usually should be solved in separate parts (or they might directly give an effective ϵ or simply use LMTD in that zone). FE problems typically avoid mixing phase change into NTU directly – so if steam condenses, you might handle that by knowing the latent heat, etc., rather than NTU. Just keep in mind, these formulas won't work if one side's temperature doesn't change (phase change at constant temp gives infinite c_p effectively, messing up C_r concept).

- *Shortcut for balanced exchanger:* If you happen to remember one formula, note that for **equal capacity flows ($C_r = 1$)**, parallel and counter formulas simplify: parallel $\epsilon = \frac{1-e^{-2\,\mathrm{NTU}}}{2}$; counter $\epsilon = \frac{\mathrm{NTU}}{1+\mathrm{NTU}}$. For quick checks: at small NTU, both ≈ NTU/1; at large NTU, parallel → 0.5, counter → 1. Knowing this can help eliminate wrong multiple-choice options if they violate these limits.

Variations and Related:

- *Heat exchanger design vs. rating:* The NTU method is often used in **design** (choosing size A for a desired ϵ) or **performance rating** (finding Q for a given A). A related concept is the **residence time** of fluid vs. how quickly heat can be transferred – NTU is essentially capturing that. A longer residence (more area, lower velocity, etc.) means higher NTU.

- *Multiple heat exchangers in series:* If you ever saw a problem with two exchangers in series (rare in FE, but conceptually), the overall effectiveness can be computed in stages, effectively combining NTUs. It's good to note: two small exchangers back-to-back can achieve what one bigger one can – e.g., two exchangers each with $\epsilon = 0.5$ could, in ideal conditions, approach the effect of one exchanger with higher effectiveness (not exactly additive, but you'd calculate sequentially).

- *Mixing vs. unmixed in cross-flow:* We gave one formula for both fluids unmixed. If one fluid is mixed (like air in many cross-flow), the effectiveness is a bit lower. Typically, charts provide separate curves for "one fluid mixed, one unmixed" vs "both unmixed." The key effect of mixing is that it prevents part of the fluid from remaining colder or hotter than the average, reducing the driving force somewhat. In exam terms, just recognize that fully unmixed is more effective than partially mixed, which is more effective than fully mixed (fully mixed on one side basically behaves closer to parallel flow in effectiveness).

- *Common values:* A well-designed heat exchanger might have an effectiveness of 0.7–0.9 for counterflow, or 0.5–0.8 for parallel/cross-flow, depending on size. Very high effectiveness (>0.9) usually means diminishing returns – you need a huge area to get that last bit of heat, so it's often not economical, but it might show up in theoretical questions. Low effectiveness (<0.2) suggests an undersized unit – perhaps intentional if only minimal heat exchange is needed. If a question says an exchanger "achieves 80% of the theoretical maximum heat transfer," they're basically giving $\epsilon = 0.8$.

Special Notes (Calculator and Exam Strategy): The effectiveness formulas for parallel and counterflow are not too bad to plug in if needed – just be mindful of parentheses. For the counterflow formula, it's easiest to calculate it stepwise:

- Compute $(1 - C_r)$ and $(1 - C_r) \cdot \mathrm{NTU}$. - Take the negative of that and exponentiate: $\exp[-(1 - C_r)\,\mathrm{NTU}]$. - Then apply the formula:

$$\frac{1 - (\text{that exp})}{1 - C_r \cdot (\text{that exp})}$$

Parallel is a bit simpler: - Compute $(1 + C_r) \cdot \mathrm{NTU}$, take negative and exp: $E = \exp[-(1 + C_r)\,\mathrm{NTU}]$. - Then $\epsilon = (1 - E)/(1 + C_r)$.

Many FE exam problems might bypass heavy computation by giving you either a simplified scenario (like $C_r = 1$ or $C_r = 0$) or by providing a chart. If a chart is given, remember that interpolation might not be worth the time – likely the needed point is on a nice round value or one of the provided curves. Also, your exam-approved calculator doesn't have solver capabilities, so if a question asked for NTU given an ϵ, you'd solve it by some iteration or logic. Typically, they won't do that – they'd rather give NTU and ask for ϵ, which is direct. If you ever needed to invert, say for $\epsilon = NTU/(1 + NTU)$ you can solve directly: $\epsilon(1 + NTU) = NTU \rightarrow \epsilon + \epsilon\mathrm{NTU} = NTU \rightarrow \epsilon = NTU - \epsilon\mathrm{NTU} = NTU(1 - \epsilon) \rightarrow NTU = \frac{\epsilon}{1-\epsilon}$. For more complex exponentials, you might have to take ln or trial-and-error. Keep an eye on answer choices; often you can plug them back into an ϵ formula to see which fits if needed.

Explanation & Analysis: The Effectiveness–NTU method shines in scenarios where you know the **hardware (U and A)** and the **inlet conditions**, and you want to predict performance. It essentially answers: "Given this exchanger, how close do we get to perfect heat transfer?" The key concept is that one fluid will run out of capacity to absorb heat before the other if their flow rates differ. The fluid with $C_{\min}$ sets the limit. If you imagine water cooling hot oil: if you have a small flow of water (low C) and a huge flow of oil (high C), the water can only absorb so much heat before it gets too hot. Even an infinite area exchanger can only cool the oil until the oil reaches the water's inlet temperature – that's the theoretical max. The NTU essentially tells you how far along you get toward that ideal.

Breaking it down:

- **Effectiveness ϵ:** It's like a performance rating from 0 to 1. If $\epsilon = 0.6$, you're getting 60% of the heat you could possibly get if you made the exchanger infinitely long. It's a convenient way to specify performance without tying it to a specific flow condition, as long as the flow rates remain the same. Engineers often use required ϵ as a spec: e.g., "we need to cool this fluid to within 5°C of the other fluid's inlet" – that implies a high effectiveness. - **NTU:** Think of NTU as how many "units" of heat exchanging capability you have relative to the smallest stream's ability to carry heat. If NTU = 1, roughly you have just enough area to transfer a significant chunk, but not all, of the energy in one pass. If NTU = 5, you have a lot of area – enough to keep transferring heat even as the temperature difference shrinks along the length. In fact, beyond NTU ~3 or 4, you get diminishing returns: going to NTU 10 might only improve effectiveness a tiny bit if C_r is not extreme.

- **Interplay of NTU and C_r:** If both fluids have equal capacity ($C_r = 1$), they meet in the middle at best. You need a very high NTU to approach that middle thoroughly (counterflow helps by making the "middle" hotter for cold fluid and cooler for hot fluid). If one fluid has a very low capacity (C_r small), it will change temperature a lot and the other fluid won't change much – those situations often yield high effectiveness even at modest NTU, because one fluid can essentially dump all its heat into a small amount of the other fluid.

- **Example intuition:** Suppose hot water ($5kg/s, c_p = 4.2kJ/kgK$) is cooling oil ($2kg/s, c_p = 2kJ/kgK$) in a counterflow exchanger. Here, $C_h = 21000W/K, C_c = 4000W/K$. So $C_{\min} = 4000$ (the oil, presumably) and C_r 0.19. The max the oil could ever gain is $4000 * (T_{water,in} - T_{oil,in})$. If the exchanger is moderately sized (say NTU = 2), what effectiveness might we get? Plugging into counterflow formula: $\epsilon \approx \frac{1-e^{-2*(1-0.19)}}{1-0.19e^{-2*(1-0.19)}}$. That's $\frac{1-e^{-1.62}}{1-0.19e^{-1.62}}$. $e^{-1.62}$ 0.199. So numerator = $1 - 0.199 = 0.801$. Denominator = $1 - 0.19 * 0.199 = 1 - 0.0378 = 0.9622$. So ϵ 0.833. That means ~83.3% of the max possible heat is transferred. So the oil will get 83% of the way to the water's inlet temp difference. If

water came in at 80°C and oil at 30°C, $\Delta T_{in} = 50°C$, $Q_{max} = 400050 = 200kW$ *(since oil is C_{min}). At 83% effectiveness, Q ~ 0.833*200 = 166 kW. The oil's temperature $rise = Q/(m_c c_p)$ = 166000/(2000) = 83°C rise(!). Starting at 30°C, that would suggest oil out at ~113°C. But it can't exceed water's inlet of 80°C. Aha – this tells us we've hit a logical snag: we computed effectiveness beyond what's physically possible because we implicitly allowed the oil to exceed the hot inlet temperature, which can't happen. The error in this thought experiment is the assumption NTU=2 with those flows might have been too optimistic without double-checking the energy balance. In reality, as the oil approaches 80°C, the ΔT shrinks and the actual Q would be limited. The formulas do handle that if used correctly – likely my quick calc assumed a scenario that in practice would mean water cooled below oil's inlet, which isn't possible without a refrigeration cycle. The takeaway: the NTU method must be applied consistent with physical limits – which it usually does if you stick to identifying C_{min} correctly and using the right formulas.

In summary, the Effectiveness–NTU method is your friend when dealing with incomplete temperature data. It's more conceptual than LMTD – you're essentially **measuring heat exchanger goodness** with ϵ and connecting it to size via NTU. On exam day, don't be intimidated by the formulas: the heavy lifting (derivation) has been done for you. Focus on selecting the right formula, plugging in the numbers carefully, and interpreting the result. If the result says 60% effectiveness, understand what that means for the system. And if a problem simply asks, "What is the effectiveness of this heat exchanger?" you know it's $\frac{Q}{C_{\min}(T_{h,in}-T_{c,in})}$ – a straightforward ratio once you find Q from energy balances or other given data.

K12.T05.S04 – Overall Heat Transfer Coefficient U for Composite Walls and Tubes

Multiple thermal barriers in series: When heat flows from a hot fluid, through a solid wall, into a cold fluid, it doesn't just *jump* across. It faces a sequence of barriers: a thin film of fluid on the hot side (**convection** resistance), then the wall material (**conduction** resistance), then a fluid film on the cold side (another convection resistance). If the wall has multiple layers or if deposits build up, those add more barriers. Each barrier *slows* the heat flow.

Definition of U: The **overall heat transfer coefficient** U is a convenient way to lump all these barriers into one. It tells you how well heat *overall* passes from one fluid to the other. High U means easy heat flow (little resistance); low U means the heat exchanger is more insulative (lots of resistance).

Thermal resistance analogy: You can think of each layer as a thermal resistance R (like electrical resistors in series). The convective layers have resistances $R_{\text{conv}} = \frac{1}{hA}$ (since convection $Q = hA\Delta T$), and the wall has $R_{\text{cond}} = \frac{\text{thickness}}{kA}$ for a flat wall (or a more complex log formula for a tube). Fouling layers (deposits) also act like added resistance. All these resistances add up in series, *hindering* the heat flow. The overall coefficient U essentially comes from the total resistance: it's defined so that $Q = UA\Delta T$ **mimics the entire series of resistances** in one go.

Big picture use: U is what you use when you need to compute the heat transfer **across composite layers**. Instead of dealing with each layer's heat transfer one by one, you combine them. On the exam, after calculating U, you'll often plug it into $Q = UA\Delta T_{(\text{appropriate})}$ (with ΔT being a temperature difference, often a log mean in a heat exchanger context).

Effect of weak links: The smallest heat transfer coefficient or poorest conductor dominates. For example, if one side has a very low convection coefficient (like air, low h), it creates a big resistance $1/hA$ that makes U low no matter how good the other layers are. Similarly, a very thick wall or a heavy fouling deposit will **bottleneck** the heat flow. In practice, improving the largest resistance (the "weak link") raises U the most.

Exam Handbook Search Cues (Not affiliated with or endorsed by NCEES): *"overall heat transfer coefficient", "thermal resistance", "composite wall", "convection coefficient"*

Footnotes:

1. *Units:* Make sure to use **consistent area** when summing resistances. In a planar wall, the area A is the same for each layer. In a cylindrical wall (tube), the inside surface area A_i and outside area A_o differ – the wall's conduction formula inherently accounts for that, but you'll typically reference U to one specific area (usually the outside area). The exam will usually provide values so you don't have to guess which area to use; just be careful to pair each h or fouling factor with the correct area in calculations if needed.

2. *Symbol conventions:* h_i and h_o usually refer to inside (inner fluid) and outside (outer fluid) convective coefficients, respectively. U may be labeled U_i or U_o in some texts depending on whether it's based on inside or outside area – but in the exam context, there's typically a single U and it's clear from context which area A to use with it. All formulations here assume **steady-state** conditions (no change in temperatures over time) and no heat generation in the wall.

Variations and related forms:

- **Planar vs. cylindrical:** For a flat wall of thickness δ, the conduction resistance is $\delta/(kA)$. For a cylindrical wall (pipe) of length L, inner diameter D_i, outer diameter D_o, the conduction resistance is $\frac{\ln(D_o/D_i)}{2\pi kL}$. The overall formula adapts accordingly. In a thin-walled tube (wall thickness much smaller than diameter), $A_i \approx A_o$, and you can approximate the cylindrical problem as if it were planar for a rough estimate.

- **Multiple wall layers:** If the wall is made of multiple materials (say, a layer of steel plus insulation), simply add each layer's conduction resistance $L_i/(k_i A)$ into the sum. The overall concept doesn't change – just more terms in the series.

- **Typical values:** Overall heat transfer coefficients U can vary widely: a well-designed water-to-water heat exchanger might have U on the order of 500–1000 W/(m²·K), whereas a poorly conducting system (say, air-to-air with fouling) might be just 5–20 W/(m²·K). The presence of **fouling** usually knocks the U value down significantly (even a thin deposit layer can cut U by 10–30% or more, as fouling's thermal resistance adds up). Always expect U to be **less than** any individual convection coefficient h; it's diluted by the other resistances in series.

Special notes (calculator usage): When calculating U on your FE-approved calculator (Casio fx-115/991, HP 33s/35s, TI-30X/36X series), it's wise to do it in steps. **Avoid trying to type the entire reciprocal expression in one go** – it's easy to misplace parentheses. Instead, calculate the total resistance first, then hit the

$\frac{1}{x}$ key (or divide 1 by that sum) to get U. For example, you might compute each term $1/h_iA, \delta/kA, 1/h_oA,$ etc. separately, sum them, then do the reciprocal. This reduces errors and lets you quickly double-check each piece. Also, watch your **units**: if thickness is given in mm, convert to m; if areas cancel out in the formula, you might not need to plug a numeric A at all (just be conceptually careful).

Equation Passport – Overall Heat Transfer Coefficient *U*

Name and purpose: Overall Heat Transfer Coefficient – computes the equivalent **heat transfer capability** of a series of thermal resistances (convection, conduction, fouling) between two fluids. It allows the heat transfer rate to be expressed in the familiar form $Q = UA\Delta T$ even when multiple layers are involved.

Formulation (composite wall example): In a simple case of one convective layer on each side and one flat wall between, the overall relationship is:

$$\frac{1}{U} = \frac{1}{h_i} + \frac{\delta}{k} + \frac{1}{h_o} + R_{f,i} + R_{f,o}\,.$$

(All terms on the right have units of (m²·K)/W*, representing thermal resistances per unit area.)*

If multiple layers or a cylindrical geometry are involved, additional terms or geometric factors (like $\ln(D_o/D_i)/(2\pi kL)$) modify the middle term – but the additive resistance concept remains the same.

Variables and units:

- U: overall heat transfer coefficient, in **W/(m²·K)**. (Sometimes given in other units like Btu/(h·ft²·°F) – be ready to convert if needed.)

- h_i: convective heat transfer coefficient of the **inner (hot) fluid**, **W/(m²·K)**.

- h_o: convective heat transfer coefficient of the **outer (cold) fluid**, **W/(m²·K)**.

- δ: wall thickness (if planar wall) or equivalent thickness of one layer, in **m**.

- k: thermal conductivity of the wall material, in **W/(m·K)**.
- $R_{f,i}$: **fouling factor** on the inner (hot side) surface, in **(m²·K)/W**.

- $R_{f,o}$: fouling factor on the outer (cold side) surface, in **(m²·K)/W**.

- A (not shown explicitly above): surface area through which heat flows, in **m²**. In the formula as written, each term is already "per unit area." For a flat wall, A is constant and cancels out. For a tube, if using the formula in this form, U is typically taken with respect to either the inner or outer surface area (so use that same A for $Q = UA\Delta T$). The terms $1/h_i$ and $R_{f,i}$ implicitly would use the inner area, $1/h_o$ and $R_{f,o}$ the outer area, and the conduction term bridges between them. (It's safer to apply the full cylindrical formula separately as noted rather than mixing areas in one expression.)

Assumptions and scope:

- **Steady state, 1-D flow:** The equation assumes steady conditions (temperatures not changing with time) and one-dimensional heat flow through the wall (no significant lateral heat leaks). This is valid for typical thin-walled heat exchanger tubes or walls where heat flows predominantly perpendicular to the surfaces.

- **No phase change in wall:** The wall is solid and dry (no condensation/boiling within the wall material). If a phase change happens in the fluid (condensation/boiling), h would effectively account for it, but U formula usage remains the same conceptually (just h values are high for phase change).

- **Uniform h and k:** We assume the convective coefficients h_i, h_o are uniform over the surface (in reality they can vary, but the exam will give a single average value). The wall's thermal conductivity k is taken as constant (no temperature dependency considered in the basic formula).

- **Fouling present or absent:** If fouling factors $R_{f,i}, R_{f,o}$ are given, we assume they're already accounting for any complex deposit behavior; we treat them like fixed resistances. If no fouling info is given, assume clean surfaces (effectively $R_f = 0$). The exam will typically state fouling explicitly if it's to be considered.

Limit checks (sanity tests):

- If the wall **thickness** $\delta \to 0$ (or $k \to \infty$, a super conducting wall), the conduction resistance vanishes. The formula then reduces to $1/U = 1/h_i + 1/h_o + R_{f,i} + R_{f,o}$. In other words, U would approach a limit governed by the fluid films and fouling only. This makes sense: an infinitely conductive wall can't slow down heat, so only the fluid resistances matter.

- If one side's convective coefficient $h_i \to \infty$ (imagine an ideal fluid that imposes no resistance, like an infinite h), then $1/h_i \to 0$. The formula becomes $1/U \approx \frac{\delta}{k} + 1/h_o + R_{f,o} + R_{f,i}$. Essentially, a very large h means that side isn't the bottleneck at all (no resistance there). **Check:** If both $h_i, h_o \to \infty$ and no fouling, then $1/U \approx \delta/k$. Then $U \approx k/\delta$, which is exactly the wall's conduction coefficient – it matches the intuitive extreme where convection is so good that only the wall limits heat flow.

- As fouling resistances $R_{f,i}, R_{f,o} \to 0$ (perfectly clean surfaces), the formula reverts to just convection + conduction terms. If fouling becomes very large (dirty), $1/U$ grows and U drops toward zero – meaning almost no heat can get through a heavily fouled surface (like an insulated pipe due to deposits). It's a good habit to mentally turn R→0 or R→∞ to see if the formula's outcome makes physical sense; here it does.

Use vs. similar formulas: Use the overall U approach **whenever multiple heat transfer steps in series** are involved. In contrast, if you only had a single mode (say just convection from a surface to fluid, or just conduction through a single layer), you'd use the simpler formula for that mode alone (e.g. $Q = hA\Delta T$ for pure convection or $Q = \frac{kA}{L}\Delta T$ for pure conduction). The U equation essentially **unites Newton's law of cooling and Fourier's law of conduction into one**. Don't confuse U with an individual h: U is *composite* and always ends up smaller than any single h or k/δ in the chain. Use U instead of trying to apply, say, the convection formula twice or conduction formula blindly through a multi-layer wall – U is the correct tool when the question hints at **combined** resistances (keywords: "overall coefficient", "composite wall/tube", "inside & outside film coefficients", etc.).

Common exam traps:

- **Forgetting to invert:** A very common mistake is to sum up the resistances (right side of the equation) and then **forget to take the reciprocal** to find U. Remember: you usually calculate $1/U$ first. If a problem asks for U, they expect the inverted sum. Tip – after

summing resistances, use that $1/x$ button! Double-check units at this stage: the sum of resistances will be in (m²·K)/W, so inverting gives W/(m²·K).

- **Mixing up areas in a tube:** If you're dealing with a cylindrical heat exchanger and the inside and outside areas differ, be careful. The conduction resistance $\ln(D_o/D_i)/(2\pi kL)$ doesn't need an area input – it's inherently per whole cylinder. But the convective and fouling resistances do depend on area. A trap is to plug values into the flat wall formula without adjusting for area differences. The exam might avoid making you do area conversions explicitly (often they give h_i and h_o already based on respective areas, and you just plug into the standard formula). Just be mindful: if you find yourself given both A_i and A_o, stick to one reference area. One safe approach is to compute **Q** via each side independently (Q = $h_i A_i(T_{wall} - T_{\text{fluid,i}})$ etc.) equate them to solve for unknown, but that's usually beyond what's needed. Usually, just use the provided U formula consistently.

- **Unit inconsistency:** Thickness in millimeters, areas in cm^2, h in W/(m²·K) – the exam might mix units to test your attentiveness. Convert everything to a consistent set (SI generally). For example, if $\delta = 5$ mm, use $\delta = 0.005$ m in the formula. And if an area cancels out (like in the flat wall formula, you might not see A explicitly), don't randomly plug one in. Just trust the per-area form.

- **Using the wrong ΔT:** When you go to compute the heat transfer Q after finding U, make sure you use the correct temperature difference. For a simple wall, it's the difference between fluid temperatures (assuming one-dimensional flow). In a heat exchanger with changing fluid temperatures, you might need the log mean temperature difference (LMTD) if they haven't simplified it. The question context will guide you: if they give inlet/outlet temps for both fluids, likely they expect use of an LMTD formula (which is another subtopic). But if it's a single wall and two steady fluids, just do $T_{\text{hot, fluid}} - T_{\text{cold, fluid}}$. Using the wrong temperature difference (like just inlet minus outlet of one fluid) would give a wrong Q. Identify the right ΔT for the scenario.

Explanation & analysis (step-by-step): When faced with a heat exchanger resistance problem, here's how you tackle it:

9. **List all layers from hot fluid to cold fluid.** For each layer, write down its form of thermal resistance. For convection layers (fluid film on surfaces), use $R = \frac{1}{hA}$. For a solid layer of thickness δ and thermal conductivity k, use $R = \frac{\delta}{kA}$ (or the cylindrical $\frac{\ln(D_o/D_i)}{2\pi kL}$ formula for a tube wall). Don't forget to include any **fouling layers**: each fouling deposit on a surface adds $R = R_f/A$ (where R_f is the fouling factor given, per unit area). If the problem statement provides R_f with units $(\text{m}^2 \cdot \text{K})/\text{W}$, it's already per area, so just add it directly to the list of resistances (it's as if $1/h$ got a little extra).
10. **Convert to a common area basis if needed.** In many exam problems, all layers share the same area A (either it's planar so obviously the same A, or for a tube they'll give you dimensions to compute inner and outer areas but often not require heavy conversion). If areas differ, you have two choices: (a) compute each resistance with its own area and then convert one set to the other's basis *before summing*, or (b) compute the total thermal resistance in terms of heat flow (which inherently handles area changes). Method (a) might involve multiplying a resistance by a ratio of areas to express it on another area's basis. This can be error-prone, so unless you're very comfortable, an easier method (b) is: find Q by treating the thermal circuit step-by-step. For example, assume a temperature drop, compute Q through inside convection $= h_i A_i(T_{\text{hot}} - T_{\text{wall,i}})$, then set that equal to Q through conduction $= kA_{\text{wall}}(T_{\text{wall,i}} - T_{\text{wall,o}})/\delta$, etc. But in most FE questions, you won't need to go that deep – they structure it so you can use the straightforward $1/U = \sum R$ approach without confusion of area (often by providing h_i, h_o such that $A_i = A_o$ or the difference is negligible or already accounted for).
11. **Sum up all the resistances.** Add the convection resistance from the hot side $1/(h_i A)$ (plus fouling if any on that side), the conduction resistance(s) through wall(s), and the cold side convection resistance $1/(h_o A)$ (plus fouling on that side). After this step, you have the **total thermal resistance** R_{total} **(per area)** between the two fluids. For example, you might get something like $R_{\text{total}} = 0.0025\ (\text{m}^2 \cdot \text{K/W})$ after plugging numbers. Keep track of this value.
12. **Invert the total resistance to get U.** Now do $U = 1/R_{\text{total}}$. Continuing the example, if $R_{\text{total}} = 0.0025$ (m²·K)/W, then $U = 400$ W/(m²·K). This U tells you the overall heat transfer per area per degree of temperature difference. Check the magnitude against intuition: does it lie between the given h_i, h_o? (It should be lower than both, typically.) Does adding fouling or thicker walls lower U as expected? A quick intuition: if you remove a resistance, U should increase; if you add one, U should drop. It's worth double-checking if, say, you accidentally added where you should have taken reciprocal. A wrong U often is off by factor of 10 or more if units were mishandled, so sanity-checking prevents blunders.
13. **Use U to find heat transfer (if required).** With U in hand, many problems will then ask for Q (the heat rate) or perhaps a required area A to achieve a certain Q. Use the basic relation $Q = UA\Delta T$. *Example:* if our $U = 400$ W/(m²·K) and the heat exchanger has $10\ \text{m}^2$ of area and a driving temperature difference of 20 K, then $Q = 400 \times 10 \times 20 = 80{,}000$ W (80 kW). If the problem instead gives a desired Q and asks for A, rearrange to $A = Q/(U\Delta T)$. Always identify the correct ΔT for the scenario (for a straightforward case, it's the difference between inlet temp of hot fluid and inlet temp of cold fluid if one pass, or the log mean difference if both fluid temperatures change significantly through the exchanger – again, look for hints in the problem statement).
14. **Double-check for fouling or extra layers:** Before finalizing your answer, ensure you included any "fouling factor" given (very easy to overlook if it's just a short phrase in the problem). Also verify units one last time – the exam might give h in say Btu/(h·ft²·°F) and ask for U in the same units. In that case, either convert everything to SI, compute, then convert back to English units at the end, or stay in English units throughout. *Micro tip:* If you keep units consistent, $1/U = 1/h_i + \cdots$ works in any unit system as long as all terms use that system. Just don't mix systems in one calculation.

By following these steps, you treat the problem **methodically**: identify layers, sum resistances, invert for U, then apply to find heat flow or required size. It's a lot like an accounting exercise for heat barriers. With practice, it becomes a quick routine – one that the FE exam will reward you for mastering, since composite heat transfer shows up frequently.

K12.T05.S05 – Fouling Factor Concept (Additional Resistance Due to Deposits)

What is fouling? In real-world heat exchangers, surfaces don't stay pristine. Over time, **fouling** occurs – a fancy term for the accumulation of unwanted material on heat transfer surfaces. This could be **scale** (mineral deposits from water), **rust** or corrosion products, **biological growth** (algae, etc.), or any kind of dirt/soot. These deposits form a coating on the wall. Importantly, that coating is usually a *poor conductor* of heat (think of limescale or rust – they tend to insulate).

Fouling factor defined: To account for the effect of these deposits without getting into messy details of material composition and thickness, engineers use a **fouling factor** R_f. This is basically an extra **thermal resistance** value to plug into your heat transfer calculations. It's expressed in the same units as an area-normalized thermal resistance (e.g. $(\mathrm{m}^2 \cdot \mathrm{K})/\mathrm{W}$). Each surface (inside tube, outside tube) can have its own R_f. The bigger R_f is, the more it resists heat flow (just like a bigger insulation R-value in buildings means less heat loss).

How it's used: In the overall U equation we discussed, fouling factors simply add to the list of resistances. For example, $1/U = 1/h_i + R_{f,i} + (\text{wall conduction}) + R_{f,o} + 1/h_o$. You treat $R_{f,i}$ exactly like another $1/h$ term – it's as if the surface got an even thinner fluid film that's stagnant. On exam day, if they provide a fouling factor, they expect you to include it. If you neglect it, your U (and thus your computed Q) will be too high, meaning you'd be thinking the exchanger is more effective than it actually is.

Why it matters on the FE Exam: Many FE problems are *conceptual* – they might ask *"What is the effect of fouling on a heat exchanger's performance?"* or give a before-and-after scenario with fouling. Understanding R_f lets you answer: fouling **increases thermal resistance** and thus **decreases the overall heat transfer coefficient** U. In practical terms, a fouled heat exchanger transfers less heat for the same ΔT, or you need a bigger ΔT (or area) to transfer the same heat as before.

Design margins: Though not heavily tested in exam calculations, know that engineers often design heat exchangers with a fouling factor built in – essentially oversizing the equipment expecting performance to drop over time. The exam might not dive into that, but it underscores that R_f is a real-life consideration baked into our formulas.

Exam Handbook Search Cues (Not affiliated with or endorsed by NCEES): *"fouling factor", "fouling resistance", "dirty surface", "deposit resistance"*

Footnotes:

1. *Units trap:* Fouling factors may be given in **English units** in some references or problems. For instance, you might see something like $R_f = 0.001$ hr·ft^2·°F/Btu. You should recognize this as a fouling factor and convert it to SI if needed (in SI that example is about 1.76×10^{-4} m^2·K/W). The FE Exam will likely keep units consistent within a problem, but always double-check. A fouling factor given in m^2·K/W should be used with h in SI units, etc.

2. *Signs and symbols:* Don't confuse fouling **factor** R_f with a friction factor f (from fluids) or other f symbols. Context is key: in heat transfer, within a heat exchanger context, R_f always means fouling thermal resistance. Occasionally, textbooks might denote the inverse of a fouling factor (like a fouling **heat transfer coefficient** similar to h), but the FE Handbook sticks to R_f in units of resistance. We'll do the same.

3. *When fouling is negligible:* The term "clean" heat transfer coefficient is sometimes used to mean the U (or h) with no fouling. If a problem says "assume clean conditions," you can set $R_f = 0$. Conversely, "dirty" or fouled conditions mean $R_f > 0$. Some exam questions might implicitly assume clean surfaces unless stated; others will explicitly give a fouling factor.

Definition Passport – Fouling Factor R_f

- **Plain-language definition: Fouling factor** (denoted R_f) is a measure of the extra thermal resistance caused by deposits on heat exchanger surfaces. It's essentially how much the *gunk* on a surface slows down heat flow. A larger fouling factor means a worse buildup and more hindrance to heat transfer.
- **Where it matters (exam impact):** Fouling factors show up in heat exchanger problems to adjust performance. On the FE exam, you might be given R_f values to include in a calculation of U, or be asked conceptually how fouling affects heat exchange. Whenever you see fouling mentioned, remember it *adds to the total thermal resistance* – making the overall coefficient U lower. It can be the deciding factor in a multi-step problem (e.g. calculating heat lost over time as fouling accumulates).
- **Common pitfall:** A frequent misunderstanding is thinking that adding a fouling factor somehow improves insulation so "less heat is lost." In an exam context, that's not a benefit – if you're designing a heat exchanger, fouling is **undesirable** because it **reduces the intended heat transfer** between fluids. Students might also mix up R_f with a safety factor or ignore it altogether. The pitfall is failing to include it in calculations: if a problem provides R_f, it's there for a reason. Numerically, forgetting a fouling resistance will give you an overestimated U and thus an overestimated Q. Always add fouling resistances for each side if given.
- **Micro-check:** *True or False:* As fouling on the tube surfaces increases, the overall heat transfer coefficient U also increases. **Answer:** False. Fouling adds resistance, which **lowers** U. (Think of it this way: fouling is like adding an insulating coat on the surface – it definitely doesn't help heat go through!)

Explanation & analysis: Fouling is conceptually straightforward: it's "stuff" on the heat transfer surface that isn't supposed to be there. Let's break down how to handle it:

- **Physically, what's happening?** Imagine a hot fluid inside a pipe trying to heat a cooler fluid outside. If the inside of the pipe is clean metal, heat zips from the fluid into the metal. But if the metal is covered in, say, calcium deposits (think of a kettle with limescale), that deposit layer acts like a **thermal bottleneck**. Heat has to conduct through this crusty layer, which usually has much lower thermal conductivity than metal (and even lower than the fluid's effective conductivity if the fluid is well-mixed). The result: less heat gets through for the same temperature difference. Engineers quantify that effect

with R_f. Each side can have its own deposit (inside tube vs outside tube), hence $R_{f,i}$ and $R_{f,o}$.

- **In calculations:** Incorporating fouling is easy if you remember to do it. Take the clean-case formula and just **add R_f terms** along with the $1/h$ and wall terms. There's no complex math – it's literally an addition of another resistance. For example, if an inner pipe surface has a fouling factor of 0.0002 m^{2}K/W, that means an extra 0.0002 m^{2}K/W goes into the $1/U$ sum. If the area basis is the same, you just add 0.0002. If working per unit area, you might see it already given in those units so you add directly. The effect on U can be significant: suppose without fouling, $1/U$ summed to 0.0020 (m²K/W). Adding 0.0002 makes it 0.0022, which means U drops from 500 to about 455 W/(m²·K) – roughly a 9% drop. More severe fouling would cause a bigger drop.
- **Preventing confusion:** It helps to conceptually separate **design mode** vs **analysis mode**. In design, you'd include a fouling factor upfront to ensure your heat exchanger will meet specs even when dirty. In analysis (what exam problems do), if they give a fouling factor, they're essentially telling you "the surface isn't ideal; account for this degradation." Just plug it in. There's no scenario in the FE exam where fouling somehow improves performance – it always hinders. So directionally, if a question asks *what happens to Q after fouling*, answer: Q goes **down** for the same driving ΔT. If they ask *what happens to required area*, it goes **up** to compensate for fouling.
- **Real-life context (just for intuition):** Fouling is why boilers, condensers, car radiators, etc. need periodic cleaning or why your home water heater element gets inefficient over time if it's caked in minerals. On the exam, you won't be figuring out *how* the fouling got there or how to remove it, but you will need to adjust your calculations for its presence. It's one of those practical factors that makes theoretical formulas match real performance.
- **Typical magnitudes:** Fouling factors are usually small numbers (on the order of 10^{-4} to 10^{-3} in SI units). Even though they're small, they're often comparable to or larger than the convective resistance of a fluid! For instance, a water-to-water heat exchanger might have $h_i \approx 1000$ W/(m²·K) (so $1/h_i = 0.001$ m^{2}K/W). A fouling layer of 0.0002 adds 20% to that resistance, which is non-negligible. If dealing with gases (low h to start with), fouling can be the straw that breaks the camel's back for heat transfer. So don't dismiss a fouling factor just because it's "a small number" – relative to other terms it can be important.
- **Double R_f means double trouble:** A quick analysis exercise: say initially $R_f = 0.0002$ m^{2}K/W and later it doubles to 0.0004. How does U change? If previously $1/U = 1/h_i + 1/h_o + 0.0002 + \cdots$, now it's $+0.0004$. The increase in total resistance is 0.0002 more, which is an incremental rise. If $1/h_i + 1/h_o +$ wall was, for example, 0.0020, then initially $1/U = 0.0020 + 0.0002 = 0.0022$. After fouling doubles: $1/U = 0.0020 + 0.0004 = 0.0024$. The new U would be $1/0.0024 = 417$ W/(m²·K) whereas before it was 455 W/(m²·K). That's roughly an 8% further drop in U. The pattern: more fouling → bigger $1/U$ → smaller U.
- **No fouling given? Assume clean:** If an exam question is silent about fouling, you can safely assume $R_f = 0$ for both sides (perfectly clean surfaces). They won't expect you to invent a fouling factor unless provided. But if they *do* provide one, they want to see you include it. It might be explicitly stated ("a fouling factor of X is present on the tube inner surface") or built into wording ("after some use, scaling has added a thermal resistance of Y"). Same thing. Just translate that into an R_f term in your $1/U$ sum.

DON'T MOVE ON YET!

Work Through Some Solid Practice Problems
while the Material of this Knowledge Is Still Fresh
THIS IS HOW THE CONCEPTS LOCK IN.

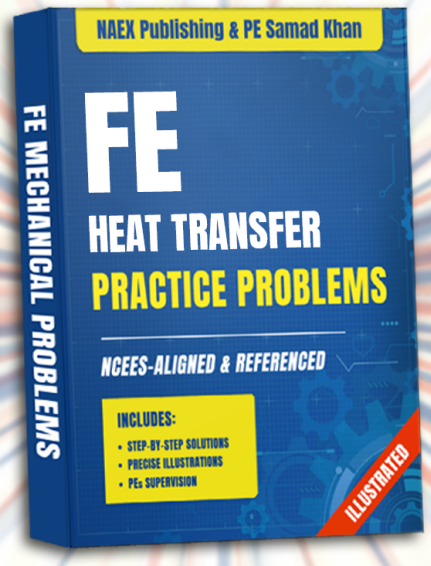

CLICK HERE TO PRACTICE

You'll be taken to our Discord Server,
where the problems are located.

KNOWLEDGE 13

MEASUREMENTS, INSTRUMENTATION, AND CONTROLS

- NAEX Publishing -

"This publication is not affiliated with or endorsed by NCEES".

Topic 01 - Sensors and Transducers

Sensors and transducers are the bridge between the physical world and measurement systems. They convert quantities like pressure, temperature, strain, etc., into electrical signals you can read and analyze. On the FE Mechanical Exam, this topic appears in instrumentation problems—think of questions asking you to compute measurement error, interpret a sensor's output, or choose an instrument with the right precision. Key terms in this chapter (accuracy, precision, resolution, sensitivity) are the exact search keywords you will use in the exam's reference. By mastering these definitions, you'll quickly spot the right formulas and avoid traps. For example, exam questions often contrast *accuracy* (how close a reading is to the true value) with *precision* (how consistent repeated readings are), or ask you to calculate the smallest voltage increment (resolution) of an ADC. Keep in mind that the official exam handbook also defines these terms clearly, so use its search function wisely during your review.

K13.T01.S01 – Measurement Accuracy

Definition/Note Passport

- **Definition:** *Measurement accuracy* refers to how close an instrument's reading is to the actual (true) value of the quantity being measured. In simple terms, high accuracy means the measured value is nearly the true value.

- **Exam Impact:** Accuracy matters when you compare a reading to a known standard or true value. On the FE exam, you might compute the percent error or absolute error of a measurement to report accuracy. For example, if you know the exact temperature is 100 °C and a sensor reads 98 °C, accuracy concerns the 2% error in that reading.

- **Common Confusion:** Don't confuse accuracy with precision. You can have precise measurements (very repeatable) that are all wrong (poor accuracy). Many students slip up by using these terms interchangeably.

- **Quick Check (True/False):** If an instrument always reads 5 units below the true value but does so consistently, it is high-precision but low-accuracy. *True or False?* (Answer: *True*.)

Exam Handbook Search Cues (Not affiliated with or endorsed by NCEES): "measurement accuracy", "accuracy definition", "error percent", "calibration" – these keywords will point you to the relevant section of the exam handbook (instrumentation).

Footnotes:

- *Often, accuracy is reported as a percentage error (e.g. ±0.5% of reading or full scale).*
- *The formula for percent error is* $\%\text{Error} = \frac{(\text{measured}-\text{true})}{\text{true}} \times 100\%$, *which you can type into any allowed calculator model.*

Variations & Typical Values:

- Absolute accuracy vs. relative accuracy (percent error) are equivalent concepts expressed differently.

- High-end instruments might have accuracy on the order of 0.01%, while cheap sensors might be 1–5% accurate.

- In problems, accuracy often appears as an ± value in the problem statement (e.g. "±2°C accuracy").

Special Notes:

- When entering formulas into calculators, remember percent means divide by 100 (or use the % key).

- On the exam, an accuracy error is typically treated as a signed quantity (positive or negative), so watch your subtraction order.

Explanation & Analysis:

Accuracy answers the question: *"How close is the measurement to the true value?"* In practice, if you calibrate an instrument (compare it to a standard), you are checking its accuracy. For instance, a scale that reads exactly 10.0 kg for a true 10.0 kg mass is perfectly accurate (zero error). If it reads 9.8 kg, it has an measurement error of –2%. In FE problems, you might be given a true value x_{true} and a measured value x_{meas}; then percent error is calculated by

$$\%\text{Error} = \frac{x_{\text{meas}} - x_{\text{true}}}{x_{\text{true}}} \times 100\%.$$

Each symbol represents: x_{true} (the exact/accepted value, in the same unit as x_{meas}), and x_{meas} (the instrument reading). A common pitfall is forgetting to use the true value in the denominator or mixing units. Always double-check unit consistency (e.g. both temperatures in °C or K) before computing error. On the exam, if you see a sensor spec like "accuracy ±1% FS", interpret it as ±1% of full-scale reading. Remember that even if a device is accurate, it could still produce random scatter – that's precision, a different topic.

K13.T01.S02 – Measurement Precision

Definition/Note Passport

- **Definition:** *Measurement precision* describes how repeatable or consistent a set of measurements are under the same conditions. In everyday terms, a precise instrument gives almost the same reading each time you measure the same thing.

- **Exam Impact:** Precision is key in statistical or repeated-measurement problems. The exam handbook notes that precision relates to the spread of repeated measurements. You might use precision when computing standard deviation or when evaluating if data points cluster tightly.

- **Common Confusion:** Precision is *not* the same as accuracy. You could hit the same wrong answer every time (high precision, low accuracy). A typical trap is assuming that "consistent readings" implies they are correct.

- **Quick Check (True/False):** Two measurements are considered precise if their difference is small, regardless of how far they are from the true value. *True or False?* (Answer: *True*.)

Exam Handbook Search Cues (Not affiliated with or endorsed by NCEES): "measurement precision", "repeatability", "standard deviation", "random error" – these terms lead to the section on measurement uncertainty.

Footnotes:

- *Precision is often quantified by statistical measures like standard deviation (σ) or range. On the exam, be ready to plug values into σ or error propagation formulas.*
- *Symbol note:* Be careful not to confuse σ (standard deviation) with σ (stress); context from the section will clarify.

Variations & Typical Values:

- High precision means small random error. Often given as ± (e.g. ±0.1 units) for consistency.

- Instruments may specify repeatability (a precision measure), e.g. "repeatability = ±0.2°C".

- Typical precision could range from 0.001 units (precision instruments) to 1 unit (low-cost devices).

Special Notes:

- No special calculator tricks here beyond normal statistics functions.
- On the exam, if you see multiple trials of data, computing a mean and standard deviation tests precision understanding.

Explanation & Analysis:
Precision answers: *"How consistent are repeated measurements?"* Imagine you weigh the same object five times. If readings are {10.01, 10.00, 10.02, 10.01, 10.03} kg, the instrument is precise (spread ±0.03 kg). In contrast, if readings vary widely (e.g. 9.5–10.5 kg), precision is low. In problems, precision often comes in via error propagation: small variations (random errors) in inputs lead to uncertainty in the result. Each symbol here (like the mean $\bar{x}$, standard deviation σ) has its usual meaning (with consistent units). The FE exam might test precision by asking for combined uncertainties using statistics formulas (see the probability/statistics section). A common error is forgetting that precision doesn't tell you *where* the cluster is on the number line – just how tight it is. For example, 99,101 are precise relative to each other (±1) but maybe not accurate if true value is 100. Always check units and make sure not to mix up "precision in percent" with "accuracy in percent."

K13.T01.S03 – Instrument Resolution

Definition/Note Passport

- **Definition:** *Resolution* is the smallest change in the measured quantity that an instrument can detect or display. In digital terms, it's the minimum increment (e.g. voltage or count) between distinct readings.

- **Exam Impact:** Resolution tells you how fine-grained a sensor or converter can be. On the exam, you might compute an ADC's voltage resolution or determine how many decimal places a measurement can have. For instance, a 10-bit ADC over 0–10 V has a resolution of $\frac{10\,\mathrm{V}}{2^{10}} = 0.00977\,\mathrm{V}$.

- **Common Confusion:** Don't mix up resolution with accuracy or precision. High resolution means you can see small changes, but it doesn't guarantee those readings are accurate or repeatable.

- **Quick Check (Conceptual):** A scale with 1 g graduation versus one with 0.1 g graduation: which has higher resolution? (*Answer:* 0.1 g graduation has higher resolution.)

Exam Handbook Search Cues (Not affiliated with or endorsed by NCEES): "analog-to-digital resolution", "bit resolution", "quantization", "least significant bit" – use these to find formulas or examples in the exam handbook.

Footnotes:

- *Resolution is often determined by the number of bits (n) in a converter: one additional bit halves the resolution step.*
- *Resolution has units (e.g. volts or meters). Make sure to keep units consistent (e.g. mV vs V) when calculating.*

Variations & Typical Values:
- **Formula form:** For an ADC spanning V_L to V_H with n bits, the voltage resolution is

$$V_{\text{res}} = \frac{V_H - V_L}{2^n}.$$

For example, 8-bit resolution (0–5 V range) gives $5/2^8 \approx 0.0195$ V per step.

- Typical ADCs on exam are 8–16 bits (common values: 4, 8, 10, 12, 16 bits).

- Mechanical gauges might have resolution like 0.1 mm or 0.001 in; digital displays often show fixed decimal places.

Special Notes:

- When typing formulas, you can use the calculator's power and subtraction functions: e.g. (VH – VL) / (2^n).
- Some calculators (TI-36X) require careful use of ^ for exponents.

Explanation & Analysis:

Resolution tells you the "step size" of a measurement. For digital sensors (like an ADC), the formula above shows that adding more bits doubles the possible steps, halving the smallest detectable voltage. Each symbol: V_H, V_L (the top and bottom of the voltage range) and n (number of bits). If $V_L = 0$, it simplifies to $V_H/2^n$. A limit check: as $n \to \infty$, $V_{\text{res}} \to 0$, meaning infinite resolution (no quantization error); as $n = 1$, $V_{\text{res}} = (V_H - V_L)/2$ (very coarse). In FE problems, resolution might appear if you're given a sensor's bit count and asked for the quantized reading or error. Remember to include units (e.g. if $V_H - V_L$ in volts, V_{res} is in volts). A common error is ignoring the offset V_L (if the converter doesn't start at 0 V). If your resolution calculation seems off by a factor of 2, re-check whether the range is inclusive or exclusive of the endpoints (the exam handbook notes that the highest representable value is one step below V_H).

K13.T01.S04 – Transducer Sensitivity

Equation Passport

- **Name & Purpose:** *Transducer Sensitivity* – gives the ratio of change in the output signal to change in the input quantity, helping you compute how much output (voltage, current, etc.) a sensor produces per unit input change.

- **Equation:**

$$S = \frac{\Delta(\text{output})}{\Delta(\text{input})}$$

A common example is a strain gauge, whose *gauge factor* GF is essentially sensitivity: $GF = \frac{\Delta R/R}{\varepsilon}$. Another example is a thermocouple, often specified in mV/°C (millivolts per degree).

- Variables & Units:

- Δ(output): change in sensor's output (e.g. volts, mV)
- Δ(input): change in measured variable (e.g. pressure in Pa, displacement in m)
- Sensitivity S units = output units divided by input units (e.g. V/Pa, mV/°C).

- Assumptions & Scope:

- Linear region: S is constant only if the sensor's response is linear over the range.

- Small changes: Sensitivity is often defined around an operating point (Δ implies a small increment).

- Out-of-scope: Nonlinear or hysteresis effects; exam usually uses linear sensors for simplicity.

- Limit Tests:

- As $\Delta(\text{input}) \to 0$, the ratio S can approach a large number if even a tiny output change is detected (the sensor is extremely sensitive).

- If $\Delta(\text{output}) = 0$ for a given input change, $S = 0$ (sensor not responding).

- **Use vs. Similar:** Use this equation for any sensor when you know how output changes with input. Do not confuse with *gain* in control systems (which is similar conceptually but used in feedback loops).

- **Common Exam Traps:** Students sometimes forget units (e.g. treating mV/°C as just a number) or mix up input/output. Also, a common mistake is to ignore the baseline output; sensitivity only covers *change* above zero (e.g. a 0 mV output at 0 Pa doesn't affect sensitivity).

Exam Handbook Search Cues (Not affiliated with or endorsed by NCEES): "transducer sensitivity", "sensor calibration factor", "strain gauge gauge factor", "voltage per pressure" – these will help locate typical examples or definitions in the exam handbook.

Footnotes:

- Sensitivity can have either sign depending on sensor polarity. For example, a thermistor's resistance decreases with temperature, but we often quote sensitivity as a positive magnitude.
- If a sensor gives a change in current instead of voltage, the output in the formula is change in current (A), not V.

Variations & Typical Values:

- **Equivalent Forms:** Instead of Δ notation, sensitivity is sometimes given as $S = \frac{d(\text{output})}{d(\text{input})}$. On the exam, Δ form is more common.
- **Strain Gauge Example:** Gauge factor $GF \approx 2$. This means 2% change in resistance per 1% strain (dimensionless ratio).
- **Thermocouple Example:** Type K thermocouple: sensitivity ~0.04 mV/°C around room temperature.
- **Pressure Transducer:** Often a few mV per psi (e.g. 10 mV/psi for a given bridge).

Special Notes:

- To enter this formula on a calculator, just divide the output change by input change (watch unit consistency).
- For input in percent strain and output in ohms or volts, remember to convert percentages to decimals (e.g. 1% = 0.01 strain).

Explanation & Analysis:

Sensitivity tells you *"how strongly the sensor responds"*. For example, if a pressure sensor has $S = 2\,\text{V/kPa}$, then a 1 kPa increase causes the output to jump 2 V. In equations, if input x changes by Δx and output y changes by Δy, we have $S = \Delta y/\Delta x$. Each symbol is straightforward: Δy (in sensor output units), Δx (in physical units). A typical task: given S and an input change, compute $\Delta y = S\,\Delta x$. For example, if $S = 0.01\,\text{A/N}$ and the force increases by 50 N, the output current increases by 0.5 A. Common pitfalls: using the wrong input or forgetting to convert units (e.g. N to kN). Notice that sensitivity is *linear gain* – if you double the input change, the output change doubles as long as the sensor remains in its linear range. In summary, sensitivity is like the "slope" of the sensor's output curve. On exam problems, you might see it tested by pairing it with resolution or accuracy (e.g. determining if the sensor can resolve a certain pressure change given its sensitivity and ADC resolution). Keep in mind that sensitivity does *not* guarantee accuracy; it only tells you the conversion factor from input to output.

K13.T01.S05 – Thermocouples (Seebeck Effect)

Principle:

- A **thermocouple** is a sensor made by joining two different conductive metals (e.g. Chromel-Alumel for Type K). When the junctions are at two different temperatures, a voltage develops (Seebeck effect).

- The *output voltage* is proportional to the temperature difference between the hot junction and the reference junction. (Often the reference is held at 0 °C or ambient).

- Thermocouples are rugged and cover a **wide range** (from about –200 °C up to >1000 °C for Type K and J). They are common in furnaces, engines, and other high-heat applications because of their high temperature capability.

- Seebeck coefficient **S** (material-dependent) is typically on the order of tens of μV/°C. For example, Type K thermocouple has around $+41\ \mu V/°C$ at $0 - 1000\ °C$. (Exact values come from calibration tables or polynomials.)

- Because voltage signals are small (milli- or micro-volts), thermocouple circuits often need high-resolution measurements or cold-junction compensation.

Equation Passport – Thermoelectric Voltage (Seebeck Effect):

- **Name & purpose:** Thermoelectric (Seebeck) Equation – computes the open-circuit voltage **V** of a thermocouple from its junction temperature difference. Use it when you know the *hot-junction* and *reference* temperatures.

- **Professional form:** $V = S\,(T_{\text{hot}} - T_{\text{ref}})$ where S is the average Seebeck coefficient of the metal pair (in V/K). (For higher accuracy over large ΔT, use the integral form or polynomial fits from tables; see exam handbook chart.)

- **Variables & units:**

- V: thermocouple output voltage (units: volts, V)
- S: Seebeck coefficient (V/K) – a constant for the two metals (often given in $\mu V/°C$; convert $\mu V/°C$ to V/K by noting $1\,\mu\text{V}/°\text{C} = 1 \times 10^{-6}$ V/K).
- T_{hot}: hot junction temperature (in °C or K; difference in K and difference in °C are same)
- T_{ref}: reference junction temperature (°C or K)

- **Assumptions & scope:** Steady-state single junction; linear approximation valid for small ΔT. Usually assume the reference junction is at known 0 °C (ice point) unless otherwise stated. Only the *difference* $T_{\text{hot}} - T_{\text{ref}}$ matters (thermocouple measures *difference*, not absolute). This formula ignores any internal resistance or loading effects.

- **Limit tests:** If $T_{\text{hot}} = T_{\text{ref}}$, then $V = 0$ (no temperature difference → no voltage). As the temperature difference grows, V grows roughly linearly. If S were zero (two identical wires), $V = 0$ regardless of ΔT.

- **Use vs. sibling equations:** Use this thermocouple equation **instead of** RTD or thermistor formulas when the problem involves a thermocouple's junctions. In contrast, use the RTD formula for resistive sensors and the thermistor exponential law for semiconductor sensors.

- **Common exam traps:** Don't forget that this formula gives voltage due to *temperature difference* – be sure to identify which junction is hot and which is reference. Watch the sign: many formulas assume $T_{\text{hot}} > T_{\text{ref}}$, giving positive V. Always match units (if S is given in μV/°C, multiply by 1e-6 to get volts). Also, most problems use the reference junction at 0 °C or 25 °C; if a different value is given, include it.

Exam Handbook Search Cues (Not affiliated with or endorsed by NCEES): thermocouple; Seebeck effect; reference junction; calibration.

Footnotes:

- *Unit nuance:* Temperature difference can be in °C or K (1 K = 1 °C difference), but use Kelvin for absolute terms. Seebeck coefficients are often listed in μV/°C, so convert to V/K for formula.
- *Scope:* Standard thermocouple formulas assume a steady, uniform temperature along each wire and a single reference junction. If the reference junction isn't 0 °C, first calculate the voltage difference from 0 °C and adjust accordingly.
- *Conventions:* On many calculators, ensure use of the correct sign for ΔT. Negative voltage (if $T_{\text{hot}} < T_{\text{ref}}$) may appear in calculations if junctions are swapped.

Variations & typical values:

- **Type variations:** Common thermocouple types (ANSI codes) include J, K, T, E, etc. Type K (NiCr–NiAl) is general-purpose (roughly –200 to +1260 °C). Type J (Fe–CuNi) covers about –210 to +760 °C. Type T (Cu–CuNi) is for low temps (–200 to +350 °C). Type E (NiCr–CuNi) has higher voltage output (–100 to +900 °C). Each has a different Seebeck coefficient and range.

- **Lookup tables:** In practice, thermocouple outputs are not perfectly linear over large spans. The FE exam provides tables/graphs of EMF vs. temperature for each type (see exam handbook charts). For rough calculations, a constant S is okay; for precise answers, use the provided data or polynomial fit.

- **Typical magnitudes:** K-type Seebeck $S \approx 41 \times 10^{-6}$ V/K near 0–400 °C. If ΔT = 100 K, expect ~0.0041 V (4.1 mV). Thermocouple voltages are usually a few millivolts per 100 °C.

Special Notes (Calculator Tips):

- No special functions needed: just multiply S by $T_{\text{hot}} - T_{\text{ref}}$. On a Casio or TI, use the multiplication key and ensure temperature and S use same units.
- If a problem gives a thermocouple table or polynomial, you may need to interpolate or evaluate a polynomial using the calculator (e.g. poly mode or successive operations). Practice entering exponents and coefficients carefully.

Explanation & Analysis:

The thermocouple formula computes the tiny voltage that develops when two different metal wires form junctions at different temperatures. In an FE problem, you might be given T_{hot} and T_{ref} and asked for the voltage or vice versa. The formula $V = S\,(T_{\text{hot}} - T_{\text{ref}})$ says each degree of temperature difference contributes S volts. In analysis, first identify which junction is hotter; then compute ΔT. Multiply by the Seebeck coefficient S (note the correct sign for that type). For example, if $T_{\text{hot}} = 200\,°\text{C}$ and $T_{\text{ref}} = 0\,°\text{C}$ with $S = 40\,\mu\text{V}/°\text{C}$, then $V = (40 \times 10^{-6}\ \text{V/K}) \times (200 - 0)\ \text{K} = 0.0080\ \text{V}$. Common mistakes include using $T_{\text{ref}} = 32\,°\text{F}$ by accident (remember to convert all to °C or K), or mixing μV and V. Also, do not confuse this with the RTD resistance formula or thermistor equations – each sensor has its own relationship.

K13.T01.S06 – Thermocouple Types and Ranges (Table)

Table Title & Purpose: Common Thermocouple Types – This table lists major thermocouple "types" (ANSI codes) along with their wire materials and typical temperature ranges. It helps you **choose the right type** for a given temperature range or match a type code with its use.

Type	Wire Materials (Positive vs. Negative)	Approx. Temperature Range (°C)
J	Iron (Fe) vs. Constantan (Cu–Ni)	–210 to +760
K	Nickel–Chromium (Ni–Cr) vs. Nickel–Alum. (Ni–Al)	–200 to +1260
T	Copper (Cu) vs. Constantan (Cu–Ni)	–250 to +350
E	Nickel–Chromium (Ni–Cr) vs. Copper–Nickel (Cu–Ni)	–250 to +1000

(Table is illustrative. Ranges above are approximate engineering values and temperatures may vary by manufacturer; see exam handbook for exact values.)

How to read & interpolate: The left column is the ANSI type letter (thermocouple code), the middle column shows the two wire alloys, and the right column gives each type's typical usable range in degrees Celsius. There is no interpolation – each type has discrete temperature limits. The exam handbook has similar tables and color codes, but on the FE you won't need color.

Units & source: Temperature in °C. This table is compiled from typical values (not a direct quote from any single source); see exam handbook (Instrumentation section) for detailed specs.

Typical exam moves: You might see a question like "Which thermocouple type is suitable up to 1200 °C?" and recognize type K or J. Or "Type T thermocouple wires are typically which metals?" (Answer: Cu vs Cu–Ni). Sometimes exam questions ask you to identify sensor by its color code or environment – you can list the materials instead.

Common pitfalls: Mixing up type names (J vs K vs T vs E) is easy. For example, Type J uses iron, not nickel alloys. Don't confuse 'Nickel–Alumel' (type K negative) with nickel-chromium (type E positive). Also, be careful with units: ranges are in °C; the exam won't mix °F for these values.

Variations & notes:

- There are many other types (R, S, B, N) not listed here, but J/K/T/E cover most FE questions.
- **Special use:** Type T is often used in cryogenics (liquid gas) because it works at very low temperatures with low self-heating. Type E has higher output voltage per degree (better resolution) but a narrower upper range.
- **Tolerance:** Each type has accuracy classes (A, B) that define how far off the EMF can be. Don't worry about those on the FE, but know that "Class B" is lower accuracy than "Class A" for platinum thermocouples.

K13.T01.S07 – Resistance Temperature Detectors (RTDs)

Principle:

- An **RTD** is a precision resistor whose resistance changes almost linearly with temperature. Most are made of platinum (Pt) because of its stability. The idea: as temperature rises, the metal's electrical resistance increases predictably.
- The **standard formula** (linear approximation) for an RTD is:

$$R_T = R_0\,[1 + \alpha\,(T - T_0)],$$

where R_0 is the resistance at the reference temperature T_0, and α is the temperature coefficient.
- For example, a common "Pt100" RTD has $R_0 = 100\,\Omega$ at $T_0 = 0\,°\text{C}$ and $\alpha \approx 0.00385$ (Ω/Ω·°C). That means each °C increases resistance by about 0.385 Ω.
- RTDs are accurate and repeatable; they work well from about –200 °C to +600 °C. (Above that, platinum starts to deviate from linearity.)

Equation Passport – RTD Resistance-Temperature Law:

- **Name & purpose:** RTD Linear Resistance Equation – relates an RTD's resistance R_T to temperature T. Use it to compute temperature from a measured resistance or vice versa.

- **Professional form:** $R_T = R_0\,[1 + \alpha\,(T - T_0)]$

- **Variables & units:**

- R_T: resistance at temperature T (Ω)
- R_0: resistance at reference temperature T_0 (Ω) – usually $T_0 = 0\,°\text{C}$. For Pt100, $R_0 = 100\,\Omega$.
- T: temperature of the RTD (°C)
- T_0: reference temperature (°C) – often 0 °C or 32 °F (0 °C) unless stated.
- α: temperature coefficient (Ω/Ω·°C) – the fractional change per °C. For platinum, $\alpha \approx 0.00385$ per °C.

- **Assumptions & scope:** Valid for moderate temperature ranges near T_0. This linear form neglects small curvature at higher T. Use T and T_0 in the same units (°C vs. °C works; K vs. K also works since only differences appear). Usually assume α is constant (true within a few hundred degrees for Pt). This formula is for single-temperature values; do not use it for dynamic or transient heat flows without check.

- **Limit tests:** If $T = T_0$, then $R_T = R_0$. If T increases, R_T grows linearly. If $\alpha = 0$ (hypothetical), then R_T would stay constant at R_0 (no sensitivity). As $T \to -\infty$, $R_T \to 0$ (practically not reached); as $T \to \infty$, R_T increases without bound in this linear model.

- **Use vs. sibling equations:** Use the RTD formula when the problem deals with a platinum resistance sensor. Don't use it for thermistors or thermocouples – those have exponential or Seebeck relationships, respectively.

- **Common exam traps:** Be careful with T_0. Many FE problems assume $T_0 = 0\,°\text{C}$ and $R_0 = 100\,\Omega$ (Pt100); check if a different base (like 32 °F) is implied. Always use the same temperature units for T and T_0 in the subtraction. Mixing °C and °F can cause errors – convert to Celsius first. Watch out for percentage vs. absolute changes: α is fractional per degree.

Exam Handbook Search Cues (Not affiliated with or endorsed by NCEES): RTD; Resistance Temperature Detector; platinum RTD; α (alpha) coefficient.

Footnotes:

- *Unit nuance:* α is given in Ω/Ω·°C (unitless per °C). So $R_0(1 + \alpha\Delta T)$ yields Ω. You can use Kelvin for T differences (ΔT in K = ΔT in °C).
- *Scope:* Real RTDs follow the Callendar–Van Dusen equation for wide ranges; the linear form is a first-order approximation. On the FE, use linear unless a problem specifies higher-order coefficients.
- *Conventions:* Pt100 means platinum with $100\,\Omega$ at 0 °C. There are Pt500, Pt1000, etc., with different R_0. If using formula, always plug in R_0 and T_0 given in the problem.

Variations & typical values:

- **Typical values:** Platinum RTDs use $\alpha \approx 0.00385\ °C^{-1}$. That yields about a 0.385 Ω/°C change if $R_0 = 100\,\Omega$. Nickel RTDs or copper RTDs exist but are less common on the FE.

- **Tolerance classes:** RTDs may be class A, B, etc. Class A (±0.15 °C at 0 °C for Pt100) is more accurate than Class B (±0.3 °C). If needed, the exam handbook has tables for RTD tolerances. Usually, exam problems either ignore tolerance or give an error band to use.

- **Use cases:** RTDs excel in accuracy and repeatability for moderate temperatures (0–500 °C). They're slower and have lower maximum temperature than thermocouples but give better precision.

Special Notes (Calculator Tips):

- This is a simple algebraic formula. No special keys needed. Just compute $\alpha(T - T_0)$, add 1, then multiply by R_0. For example, on a TI: enter 0.00385*(T-T0), then +1, then *R0.

- If the FE problem gives a table or graph of resistance vs. temperature, you might need to interpolate linearly or use the linear formula to check it. Many calculators can store R_0 and α in memory for quick reuse.

Explanation & Analysis:

The RTD formula $R_T = R_0[1 + \alpha(T - T_0)]$ tells you how the resistor changes with temperature. In an exam question, you might be given a resistance value and asked for temperature. To solve that, rearrange to $T = T_0 + \frac{R_T/R_0 - 1}{\alpha}$. For example, if $R_T = 110\,\Omega$, $R_0 = 100\,\Omega$, $\alpha = 0.00385/°C$, and $T_0 = 0\,°C$, then

$$T = 0 + \frac{110/100 - 1}{0.00385} = \frac{0.10}{0.00385} \approx 25.97\,°C.$$

You should double-check: at 25.97 °C, R_T should be $100[1 + 0.00385 \cdot 25.97] \approx 110\,\Omega$.

Watch for unit consistency. For instance, if the problem gives T in °F, convert to °C before using this formula. Similarly, if R_0 was specified at 32 °F (0 °C) or 0 °C, make sure T_0 matches. A common pitfall is using the wrong T_0. In most problems, assume $T_0 = 0\,°C$ and R_0 at that point (often $100\,\Omega$). In summary, identify α and R_0 for the given RTD, plug in the temperature difference, and solve for the unknown.

K13.T01.S08 – Thermistors (NTC)

Principle:

- A thermistor is a semiconductor-based, temperature-sensitive resistor (often made from metal oxides). It commonly has a **negative temperature coefficient** (NTC), meaning its resistance drops as temperature rises.

- The basic model for an NTC thermistor's resistance is exponential (Boltzmann relation):

$$R(T) = R_0 \exp\left[\beta\left(\frac{1}{T} - \frac{1}{T_0}\right)\right]$$

where R_0 is the resistance at reference temperature T_0, T is the current temperature (in kelvins), and β is a constant (in kelvins).
- In practice, thermistors often use $T_0 = 298.15$ K (25 °C) and give β between about 3000 K and 5000 K. For example, a typical 10 kΩ NTC at 25 °C might have $\beta = 3977$ K.
- Unlike RTDs, thermistors are **nonlinear** over wide ranges. They are very sensitive at low temperatures (large % change) and are used for things like temperature compensation circuits, low-cost probes, or safety thermostats.

Equation Passport – Thermistor Resistance-Temperature (NTC):

- **Name & purpose:** Thermistor Exponential Law – relates an NTC thermistor's resistance R_T to temperature T. Use it when computing temperature from a measured resistance (or vice versa) for an NTC thermistor.

- **Professional form:**

$$R_T = R_0 \exp!\left[\beta\left(\frac{1}{T} - \frac{1}{T_0}\right)\right]$$

Variables & units:

- R_T: resistance at temperature T (Ω)
- R_0: resistance at reference temperature T_0 (Ω) – typically given at $T_0 = 25\,°C$ (298.15 K).
- T: temperature (K) – *use absolute kelvins in the formula*.
- T_0: reference temperature (K) – often 298.15 K (25 °C).
- β: thermistor constant (K) – material-dependent (typically ~3000 K to 5000 K for common NTCs).

- **Assumptions & scope:** Valid for NTC thermistors (negative coefficient). This model assumes a single β parameter over the range from T_0 to T. In reality, β can vary slightly with T, but this equation is generally acceptable for FE purposes. Both T and T_0 must be in kelvins. Do not use this for PTC thermistors (they have positive coefficient).

- **Limit tests:** As $T \to T_0$, $1/T - 1/T_0 \to 0$ so $R_T \to R_0$. As T increases (becomes much larger than T_0), the exponent $\beta(1/T - 1/T_0)$ becomes negative and large in magnitude, making R_T very small (resistance drops). As $T \to 0$ K, $R_T \to \infty$ (the exp argument $\to +\infty$). This matches NTC behavior.

- **Use vs. sibling equations:** Use this formula for thermistors with negative temperature coefficients. In problems involving platinum RTDs or thermocouples, do *not* use this exponential form. Also, note that some PTC thermistors use a different (often simpler) exponential form or require only qualitative understanding (like a resettable fuse); but PTCs are rare on the FE.

- **Common exam traps:** Always convert Celsius to kelvins: $T(\text{K}) = T(°\text{C}) + 273.15$. Forgetting this is a big source of error. Another trap: confusing β (in K) with α (in 1/K or 1/°C) – do not mix them up. Ensure you use the correct R_0 for the T_0 given (commonly R at 25 °C).

Exam Handbook Search Cues (Not affiliated with or endorsed by NCEES): thermistor; negative temperature coefficient; β constant; Steinhart-Hart.

Footnotes:

- *Symbol note:* β (beta) is usually given in kelvins. Sometimes FE problems call it the "material constant." Don't confuse it with the unitless α from RTDs.
- *Units:* Temperatures in the formula must be in kelvins (K) because of the 1/T terms. You can work in °C for the difference

$T_0 - T$ if you first convert both to K. Resistances are in ohms (Ω).
- *Scope:* The exponential formula is accurate enough for most purposes. For very precise results, the **Steinhart–Hart** equation (cubic form) can be used, but that is beyond FE scope. Often, the exam will provide enough data (like two points or a β value) to use this formula directly.

Variations & typical values:

- **Steinhart–Hart equation:** In high-precision data sheets, a 3-term model is used: $\ln(1/T) = A + B\ln(R) + C[\ln(R)]^3$. You *won't* need to derive or memorize that for FE, but you might see it listed in the handbook. Usually, a β formula or calibration table suffices.

- **Typical β values:** For common NTC thermistors, $\beta \approx 3000$–4500 K. Lower β means less sensitivity (flatter curve). A typical 10 kΩ at 25°C might use $\beta \approx 3950$ K. If you need a rough check, plug numbers: e.g., at 25°C (298 K) and 125°C (398 K) with β=3950 K, the ratio $R_T/R_0 = \exp[3950(1/398 - 1/298)] \approx 0.25$, so $R_T \approx 2.5$ kΩ.

- **PTC thermistors:** Some thermistors increase resistance with T (PTC). They are less common on the FE, but if encountered, they are often used as over-temperature sensors or resettable fuses. Their $R(T)$ also follows a curve, often approximated by the same exponential law (just with β negative for PTC).

Special Notes (Calculator Tips):

- To compute $R_T = R_0 e^{\beta\left(\frac{1}{T} - \frac{1}{T_0}\right)}$, do the steps carefully: first calculate $\frac{1}{T}$ and $\frac{1}{T_0}$ (use the "1/x" key on TI or Casio), subtract them, multiply by β, then take the exponential. For example, on a TI-36X: enter 1/[Kelvin T], subtract 1/[Kelvin T0], multiply by β, then press e^x.
- Many calculators have a built-in INV (inverse) and exp or e^x function. Alternatively, use exp() function with the entire exponent as the argument. Double-check you don't accidentally use degrees.
- Some FE problems may give R_1 at T_1 and R_2 at T_2 and ask for β. In that case, you can take the ratio of two versions of the formula and solve for β (beyond the simple linear guess).

Explanation & Analysis:

The exponential formula captures how an NTC thermistor's resistance drops off with rising temperature. To use it, always convert the given temperatures to kelvins. If solving for T given R_T, take natural log and rearrange: $\beta(1/T - 1/T_0) = \ln(R_T/R_0)$. Then solve $1/T = \frac{1}{T_0} + \frac{1}{\beta}\ln(R_T/R_0)$. For example, suppose $R_0 = 10000\,\Omega$ at $T_0 = 298.15$ K (25 °C), $\beta = 3950$ K, and the measured $R_T = 5000\,\Omega$. Then

$$\ln(R_T/R_0) = \ln(0.5) = -0.6931,$$

$$\frac{1}{T} = \frac{1}{298.15} + \frac{-0.6931}{3950} = 0.003354 + (-0.0001754) \approx 0.0031786\ \mathrm{K}^{-1},$$

so $T \approx 314.6$ K (41.5 °C). Common mistakes: using Celsius directly (never do 1/(°C)), or forgetting to include the minus sign in the exponent (the formula already handles sign). Remember: a large drop in resistance indicates a small increase in temperature, due to the exponential sensitivity.

K13.T01.S09 – Strain Measurement: Strain Gauges & Wheatstone Bridges

- Strain gauges are thin resistive sensors bonded to a component; they change resistance proportionally to the component's strain.
- The **gauge factor (GF)** quantifies this: GF is defined as the ratio of fractional resistance change to strain. Typical metal foil gauges have GF ≈ 2; semiconductor gauges have much higher GF (tens to hundreds).
- A Wheatstone bridge is used to detect small ΔR. In a balanced bridge (no strain), the output voltage $V_o = 0$. When one gauge's resistance changes (strain applied), the bridge unbalances and produces an output voltage proportional to ΔR.
- Gauges can be wired in quarter-, half-, or full-bridge configurations. A full-bridge (4 active gauges) yields maximum sensitivity; a half-bridge (2 active) gives moderate sensitivity and partial temperature compensation; a quarter-bridge (1 active, 3 fixed) is simplest but least sensitive.

Exam Handbook Search Cues (Not affiliated with or endorsed by NCEES): *strain gauge*, *gauge factor (GF)*, *Wheatstone bridge*, *bridge output*, *quarter-bridge*, *half-bridge*, *strain measurement*.

Footnotes:

- *ε* (strain) is dimensionless (ΔL/L); positive for tension, negative for compression.
- *GF* is unitless. Metal gauges: GF ≈ 2.00; semiconductor: GF ≈ 50–200.
- *R* and *ΔR* are in ohms (Ω); voltages in volts (V).
- Assume small strain (ΔL ≪ L), so linear approximations hold (ΔR ≪ R).
- Elastic materials: σ = E·ε (SI: Pa = N/m² if E in Pa). Convert units if using USCS (e.g. psi).

Gauge Factor Equation – Relates a gauge's resistance change to applied strain.

$$GF = \frac{\Delta R/R}{\varepsilon}.$$

- **Variables & Units:** *GF* = gauge factor (–); *ΔR* = change in resistance (Ω); *R* = base (unstrained) resistance (Ω); *ε* = strain (–).

- **Assumptions:** Uniform strain over gauge; material remains linear-elastic.

- **Limit tests:** If ε→0 (no strain), then ΔR→0 (bridge stays balanced). The formula formally gives 0/0. If ΔR=0, then $V_o = 0$.
- **Use vs. alternatives:** Use this when *GF* is given to find ε or ΔR. (If GF is unknown, you could rearrange *GF = (ΔR/R)/ε* to compute it.)

- **Common pitfalls:** Confusing ΔR with R, or mixing up which is numerator/denominator. Remember GF is dimensionless. Watch the sign: tension (positive ε) gives ΔR > 0 in a tension gauge, compression gives ΔR < 0.

Wheatstone Bridge Output (Quarter-Bridge) – Computes the bridge's output voltage when one arm changes.
General form: $V_0 = V_S\left(\frac{R_2}{R_1+R_2} - \frac{R_4}{R_3+R_4}\right)$. For a simple quarter-bridge with R1=R2=R3=R and R4=R+ΔR (ΔR≪R):

$$V_0 \approx \frac{V_S}{4}\frac{\Delta R}{R}.$$

- **Variables & Units:** V_S = supply voltage (V); V_0 = bridge output (V); R = nominal arm resistance (Ω); ΔR = change in one arm (Ω).

- **Assumptions:** Only one arm changes (others equal); initial bridge balanced; ΔR ≪ R (linear approximation).

- **Limit tests:** If ΔR→0, then V_0→0 (balanced bridge). As R increases (stiffer circuit), $V_0 \propto 1/R$ (smaller output for fixed ΔR).

- **Use vs. alternatives:** Use this for a quarter-bridge (1 active gauge). For a full-bridge (4 active gauges under equal strain), the output is about 4× larger (each arm contributes).

- **Common pitfalls:** Forgetting the 1/4 factor. Identify which arm changed. Ensure correct polarity: label + and – nodes so you assign the sign of V_0 consistently.

Variations & Typical Values:

- *Gauge factors:* Usually given or found in material data. Metal foil ~2.0 (±5%). Semiconductor up to ~100+.

- *Bridge configurations:* Full-bridge (4 active) gives 4× sensitivity of a single gauge. Half-bridge (2 active) gives 2×. Exams may specify configuration.

- *Sensitivity example:* GF=2, V_S=10 V, ε=1000 με (0.001). Then ΔR/R = 0.002, so $V_0 \approx (10/4)$*0.002 = 0.005 V (5 mV). This shows typical output is in millivolts per volt excitation.*

- Stress from strain: *$\sigma = E\cdot\varepsilon$. For steel (E≈200 GPa), $\varepsilon=500\times10^{-6}$ ⇒ $\sigma \approx 100$ MPa. Check units: if E in Pa, σ is in Pa.*

- Temperature compensation: Temperature changes also alter R. A quarter-bridge can use a dummy (compensating) gauge to cancel thermal effects. A full-bridge can self-compensate if all gauges experience the same ΔT (the arrangement cancels uniform shifts).

Calculator Tips: Use parentheses: e.g. enter (DeltaR/R) or (Vs/4)*(DeltaR/R) carefully. Convert με to decimal (1000 με = 0.001). On calculators like Casio fx-991 or TI-36X, use ENG mode or scientific notation for small values, and double-check unit consistency.

Explanation & Analysis: Strain gauges work by converting a small length change ΔL into a tiny change in resistance ΔR. When a gauge is strained by ε, its fractional resistance change is ΔR/R = GF·ε. For example, with GF=2.0, ΔR/R = 2ε (so a strain of 0.001 yields ΔR/R=0.002).

Because ΔR is very small, the gauge is placed in a Wheatstone bridge. With supply V_S, a balanced bridge (all R equal) gives V_0=0. When R changes to R+ΔR in one arm, the midpoint voltages shift and the output becomes nonzero. For small ΔR, the approximate output is $V_0 \approx (V_S/4)(\Delta R/R)$. Substituting ΔR/R = GF·ε gives $V_0 \approx (V_S/4)\, GF\, \varepsilon$. Each symbol: V_S in volts, GF and ε dimensionless, so V_0 is in volts. If ε>0 (tension), ΔR>0 in a typical gauge, and the designated node's voltage rises.

Practically, you use these relations to solve exam problems. For instance, knowing V_0 and V_S, solve $\varepsilon = \frac{4V_0}{V_S\, GF}$. Common mistakes include losing the 1/4 factor or forgetting to convert με to a plain number. Always label the positive node of the bridge so you get the sign right. Finally, recall the **exam handbook** keywords: searching "gauge factor" or "Wheatstone" in the handbook helps verify formulas under time pressure. In summary: *Strain gauge → ΔR (via GF) → bridge → V_0*, and invert as needed to find ε or σ.

Sources: Concepts verified against the official FE Reference Handbook for consistency.

K13.T01.S10 – Manometers

A **manometer** is a U-shaped or single-column tube filled with a fluid; pressure differences cause the fluid columns to rise or fall. Manometers are based on hydrostatic equilibrium: the pressure at the same horizontal level in a connected fluid is equal.
When one side is exposed to a pressure P_0 and the other side to P_2, the pressure difference $\Delta P = P_0 - P_2$ balances the weight of the fluid column(s). Thus the fluid height difference h encodes ΔP.

If two different fluids (densities ρ_1, ρ_2) fill each leg, the net height difference depends on the density difference. Often one fluid is gas (low density) and the other a liquid (higher density).

Manometers can measure **gauge pressure** (if one side is open to atmosphere) or differential pressure. They require static conditions (no flow). In practice, heavy fluids (like mercury) are used for large pressures to keep h manageable.

Equation Passport – Manometer Pressure Relation

- **Name & Purpose:** Manometer equation – relates pressure difference to fluid column heights. Use it to compute the unknown pressure given fluid density and height.

- **Equation:** For a simple U-tube:

$$P_0 = P_2 + \rho_2 g h_2 - \rho_1 g h_1.$$

In the common case where the column heights are measured from a common datum with difference h, and fluid 1 and 2 have densities ρ_1, ρ_2:

$$P_0 = P_2 + (\rho_2 - \rho_1)\, g\, h.$$

(If one fluid is air/vacuum, set $\rho_1 = 0$ and $h_1 = 0$.)

- **Variables & Units:**

- P_0, P_2 – pressures at the two openings (Pa or lbf/ft²). P_0 often the unknown or left-side pressure, P_2 a reference (e.g. atmospheric).
- ρ_1, ρ_2 – densities of the fluids (kg/m³ or slugs/ft³).
- h, h_1, h_2 – vertical height differences in the manometer legs (m or ft). $h = h_2 - h_1$ if referenced to same level.
- g – acceleration of gravity (9.807 m/s² or 32.174 ft/s²).

- **Assumptions & Scope:**

- *Hydrostatic, static fluids* (no flow, steady).
- Heights h measured vertically.
- Uniform fluid densities.
- We use gauge/absolute pressures as given; if measuring gauge pressure, one side may be at atmospheric.
- Out of scope: transient flows or compressible effects. (Only small pressure differences measured; the FE exam won't ask compressible manometer problems.)

- **Limit tests (sanity checks):**

- If $h = 0$, then $P_0 = P_2$ – no height difference means equal pressure.
- If $\rho_2 = \rho_1$, then $P_0 = P_2$ (identical fluids).
- As h increases, $P_0 - P_2$ increases linearly: a taller liquid column means a larger pressure difference.

- Use vs. Sibling Equations:

- Use this equation *instead of* Bernoulli's equation when dealing with static pressure measurement by fluid columns. (Bernoulli is for flow; the manometer formula is for static gauge readings.)

- Common Exam Traps:

- Mixing up which pressure (gauge vs. absolute) is on each side. Always label which side sees atmospheric or vacuum.
- Forgetting that height difference h must be vertical; slanted lengths do not directly apply.
- Using ρ when γ (specific weight) is given or vice versa: recall $\gamma = \rho g$. (The exam handbook uses both notations.)
- Neglecting unit consistency: if using USCS, remember g_c or convert units so ρg yields lbf/ft².

Exam Handbook Search Cues (Not affiliated with or endorsed by NCEES): *manometer*, *hydrostatic head*, *fluid column pressure*. Use these keywords in the exam's handbook search to find the manometer formulas or examples.

Footnotes:

- *Units:* ρ in kg/m³ (or slug/ft³), $g = 9.807$ m/s^2 (or 32.174 ft/s²). Pressure P comes out in Pa or lbf/ft².
- *Gauge vs. Absolute:* This formula is general. If one side is open to air, you can set that pressure to the atmospheric pressure P_{atm}. Then P_0 is absolute; often one solves for $P_0 - P_{\text{atm}}$ (gauge pressure).
- *Sign Convention:* Ensure h is taken as positive in the direction you defined; a common trap is a sign error if you subtract heights incorrectly.
- *Static Fluid:* No acceleration term – this doesn't apply if the container is accelerating or sloshing.

Variations & Special Cases:

- If the manometer uses a *single fluid* (e.g. mercury), then $\rho_1 = \rho_2$ and one height side may be open. For example, if one side is atmosphere and you measure a single fluid column height h, then $\Delta P = \rho g h$.
- For a differential manometer (two unknown pressures P_A, P_B on each side), apply $P_A = P_B + (\rho_2 - \rho_1)gh$.

- **Typical values:** Mercury ($\rho \approx 13600$ kg/m³) is ~13.6 times heavier than water. Thus 1 m of Hg column ≈ 133 kPa (about 1 atm). Water ($\rho = 1000$ kg/m³) gives ~9.8 kPa/m. Manometers often use mercury or oil for ease of calibration.

Special Notes:

No special calculator tricks are needed beyond careful unit entry. You may need to enter $*$ for multiplication: e.g. rho*g*h. There is no built-in "manometer" function on FE-allowed calculators, so handle as a standard algebraic expression.

Explanation & Analysis:

A manometer balances pressures via fluid weight. To use it on exam day, sketch the U-tube and label the pressures at the fluid surfaces. Write "P at same depth is equal" for both sides. From the diagram, deduce which column height is higher – the heavier fluid columns rise if the pressure pushing them is greater. Then apply $P_0 + \rho_1 g h_1 = P_2 + \rho_2 g h_2$. Solving gives the formula above. In practice, label each symbol clearly: P_0, P_2 in Pa or psi, ρ in kg/m³ (remember 1000 kg/m³ = 1 g/cc water), and h in meters. Check units: $\rho g h$ yields Pa (kg·m/s²·m² = kg·m/(s²·m²) = Pa). Common mistakes include plugging h with the wrong sign or forgetting that g must be positive. Always verify: if h goes to zero or fluids have equal density, your equation predicts $P_0 = P_2$. This sanity check catches sign or density errors. Finally, remember the result gives **absolute pressure** P_0 if P_2 was absolute, or gauge pressure difference if one side was ambient.

K13.T01.S11 – Bourdon Tube Gauge

- A **Bourdon tube gauge** is a mechanical instrument used to measure pressure (typically gauge pressure). It uses a curved, hollow metal tube that tends to straighten as the internal pressure rises. The tube is connected to a pointer mechanism. As pressure pushes outward on the tube wall, the tube flexes; this motion is translated to the dial readout.
- These gauges are common in industry for moderate pressures (from a few psi up to hundreds of psi). They measure pressure by elastic deformation rather than fluid height. No formula is needed to use the gauge reading directly – it is typically calibrated to read pressure units.
- In essence, a Bourdon gauge translates pressure into a mechanical displacement; the scale on the dial is often linearized but the underlying tube response is slightly nonlinear.

Definition/Note Passport – Bourdon Tube Gauge:

- **Definition:** A Bourdon tube is a curved metallic tube (like a C-shape or coil) that deforms elastically under internal pressure. The tube's end moves (straightens) as pressure increases, driving a pointer on a dial to indicate pressure.

- **Exam Impact:** Bourdon gauges are often referenced in control and instrumentation questions. You might see it in a problem asking "Which instrument would measure this pressure?" or in troubleshooting scenarios. Remember: it measures *gauge* pressure relative to atmosphere (not vacuum). The exam may not provide a formula for it, but you might need to recognize that it indicates pressure and that the output is mechanical.

- **Pitfall/Confusion:** A common confusion is gauge versus absolute pressure. A Bourdon gauge usually reads zero at atmospheric pressure (gauge mode). Students might forget to add atmospheric pressure if the question asks for absolute pressure. Also, the tube's motion is only roughly linear; treat the provided scale as exact since calibration is built-in.

- **Quick Check (True/False):** "A Bourdon tube gauge can measure steady (static) pressure without any additional electronics." **Answer:** True – it directly deflects under static pressure. However, it does **not** generate a usable electrical signal by itself (it just moves a dial).

Exam Handbook Search Cues (Not affiliated with or endorsed by NCEES): *pressure gauge*, *Bourdon*, *diaphragm*, *elastic deformation*. (The handbook may not name "Bourdon," but searching "pressure gauge" or "elastic tube" can lead to related concepts.)

Footnotes:

- *Gauge vs. Absolute:* By design, a Bourdon gauge reads **gauge pressure** (pressure above ambient). The pointer reads zero when its inlet is at atmospheric pressure. If the problem requires absolute pressure, be sure to add atmospheric pressure (~101.3 kPa or 14.7 psi).
- *Material & Limits:* Bourdon tubes are metal (brass, bronze, stainless steel). They are accurate for steady pressures but not ideal for highly pulsating or very low pressures (creep or hysteresis can occur).
- *Units:* You may see Bourdon gauges in psi, bar, kPa, etc. The exam will make clear which units are in use. No special units conversion is needed beyond the usual (e.g. 1 bar = 100 kPa).

Variations & Related Forms:

- Bourdon tubes come in C-shapes or spiral/coiled shapes; coiled tubes fit a larger length in a small space and can measure higher pressures. The exam will not ask you to calculate the deflection; just know it signals pressure.

- There are also diaphragm gauges (thin membrane that bends) and bellows gauges (expanding chamber), which operate on similar concepts. In contrast to a Bourdon, a diaphragm gauge is flat; a Bourdon is curved tube.

- **Typical Ranges:** Many industrial Bourdon gauges cover 0–100 psi up to 0–3000 psi (0–20 MPa). Precision might be ±1–2%. For exam purposes, you might see values like 20 psi or 200 kPa.

Special Notes:

No formulas or calculator entries are needed specifically. If a numeric problem gave a Bourdon deflection coefficient (rare on the FE), you would treat it like any mechanical relationship. Typically, the exam will present a Bourdon gauge reading and expect you to interpret it as pressure.

Explanation & Analysis: The key understanding is that a Bourdon tube converts pressure into mechanical movement. The tube's cross-section is typically oval; as internal pressure rises, the tube tries to become more circular, causing its end to move outward. That motion (often amplified by gears) moves a dial pointer. On the FE exam, you should recognize mentions of Bourdon tubes in word problems: e.g., *"A Bourdon gauge reads 150 kPa. What is the absolute pressure?"* implies adding atmospheric pressure if needed. There's no pressure formula like with a manometer; instead, you recall it is a **gauge** instrument. Be wary of any twist: some gauges are filled with fluid (liquid-filled) for damping, but that detail rarely affects calculations on the exam. Lastly, Bourdon gauges do not respond instantly to very rapid pressure fluctuations (they have some inertia), so they are best for relatively steady pressures. If the exam question contrasts dynamic vs. static sensors, note that a Bourdon gauge cannot measure very fast-changing pressures (unlike a piezo sensor below).

K13.T01.S12 – Piezoelectric Pressure Transducers

- **Piezoelectric effect:** Some materials (such as quartz and certain ceramics) produce an electric charge when they are mechanically stressed, and conversely they undergo a small deformation when an electric field is applied. This is the basis of piezoelectric sensors.
- In a **piezoelectric pressure transducer**, pressure on a diaphragm is transferred to a piezoelectric crystal or ceramic. The crystal's deformation produces a voltage or charge proportional to the applied pressure. These devices are used for dynamic pressure measurements (e.g. vibration, shock, or rapidly changing pressures) because they respond quickly. They are *not* typically used for steady (static) pressure monitoring, since the generated charge can leak away.
- Common materials include quartz (for stable, precision sensors) and PZT (lead zirconate titanate, a ceramic with high sensitivity). The electric output often requires an amplifier or charge converter to produce a usable voltage reading.

Definition/Note Passport – Piezoelectric Effect in Sensors:

- **Definition:** The piezoelectric effect is the property of certain crystals/ceramics to generate an electrical potential when they are mechanically stressed. A piezoelectric sensor uses this effect to turn applied pressure or force into a voltage signal.

- **Exam Impact:** Piezoelectric sensors often appear in control or instrumentation questions, especially those involving dynamic measurements (e.g. measuring engine knock, impact forces, or high-frequency pressure oscillations). You might need to identify when piezoelectric sensing is appropriate (vs. strain gauges or capacitive sensors, etc.).

- **Pitfall/Confusion:** Remember that piezoelectric sensors **do not give a stable output for a constant pressure** (they act like a capacitor that discharges slowly). A common student mistake is assuming they measure static pressure like a gauge. In reality, if the pressure is steady, the voltage will drop to zero. Thus, piezo devices are for changing pressures or acceleration.

- **Quick Check (True/False):** "A piezoelectric pressure sensor can directly measure absolute pressure with no drift over time."
Answer: False. The sensor can measure pressure changes (and can be zeroed at a reference point), but it is effectively a charge sensor, not a sealed reference to vacuum.

Exam Handbook Search Cues (Not affiliated with or endorsed by NCEES): *piezoelectric*, *d33*, *dynamic pressure transducer*. (The FE Handbook may include "piezoelectric effect" in the materials section, so use "piezoelectric" in the search.)

Footnotes:

- *Output Units:* Piezoelectric sensors often specify sensitivity in pC/N (picocoulombs per newton) or mV/MPa. If an exam problem gives such a sensitivity, use $Q = d \cdot F$ (charge = constant × force) or $V = Q/C$ if capacitor equivalence. However, such detailed calculations are rare on FE.
- *Charge vs. Voltage:* A crystal generates charge $Q \propto F$. If connected to a circuit, this appears as a voltage V across the sensor's internal capacitance. The exam typically abstracts this; treat it as "voltage output ∝ pressure input."
- *Dynamic Behavior:* Piezoelectric sensors have extremely fast response. They are effectively high-pass devices, so exam questions about transient pressures (impacts, explosions) might hint "piezo sensor" as the measurement device.

Variations & Related Forms:

- Some transducers use piezoresistive (strain gauge) or capacitive diaphragms instead. Unlike piezoelectric ones, those can measure static pressure. Know that on the FE exam: *piezoelectric → dynamic only*; *piezoresistive strain gauge → can do static.*

- **Typical Values:** A strong piezoelectric crystal may have a charge constant d_{33} around $100–500 \times 10^{-12}$ C/N. This means a 1 kN force yields $10^{-7}–5 \times 10^{-7}$ C of charge. In terms of pressure, if the active area is 1 cm² and you apply 0.1 MPa, the output might be on the order of millivolts after amplification.

- Some piezoelectric sensors are **uncoated**, requiring isolation from high humidity. There are also **piezoelectric accelerometers** (same principle, but measure vibration); the exam might treat these similarly under "dynamic sensing."

Special Notes:

On the exam's calculator, there is no special function needed for piezoelectric formulas. If a problem gives a sensitivity (e.g. "10 mV per MPa"), you simply multiply: $V = (\text{sensitivity})(P)$. Use parentheses carefully: e.g., for 10 mV/MPa and $P = 0.5$ MPa, input 10e-3*0.5.

Explanation & Analysis:

A piezoelectric pressure sensor essentially consists of a tiny crystal sandwiched behind a diaphragm. When pressure P is applied, a force $F = PA$ (pressure times area) acts on the crystal. The crystal produces an electric charge $Q = d \cdot F$, where d is the piezoelectric constant. In terms of exam concepts, you can think "pressure → strain → charge." On a block diagram, the sensor translates pressure changes into voltage changes. The key is that this voltage *only* exists while the pressure is changing or held by an amplifier. For calculation, identify the constant: if given d or sensitivity S (volts per unit pressure), just use $V = S \cdot \Delta P$. Common mistakes include trying to use this for steady pressures (it will give zero after equilibrium) or mixing up d_{33} vs. d_{31} (two orientations of deformation – usually the exam won't require those details). In summary, treat piezo sensors as yielding $V \propto P$ instantly, but note "no DC." Check your units: a sensitivity might be in μC/N or mV/psi; convert to SI if needed (1 psi ≈ 6.895 kPa). On exam, a question might provide the voltage output and ask for the applied pressure; solve by dividing by the sensitivity. Always include a polarity check: if pressure decreases, the output voltage may go negative (the exam may mention "positive when compression").

K13.T01.S13 – Transducer (Sensor) Definition

- A transducer is a device that takes some physical quantity—such as temperature, pressure, or position (and produces a corresponding electrical output that can be measured or processed).
- The output is often very small (millivolts or microvolts) for minor physical changes.
- Transducer **sensitivity** links change in input to change in output (for example, volts per degree Celsius or volts per psi).
- **Key point:** The raw sensor output usually needs conditioning (gain, offset, etc.) before use.

Exam Handbook Search Cues (Not affiliated with or endorsed by NCEES): transducer; sensor; sensitivity.

Footnotes:

- The exam handbook uses "transducer" and "sensor" interchangeably. Don't confuse these with *transmitters*, which typically include built-in conditioning.
- Output units are typically volts or amps. If given in mV or µA, convert to volts or amperes first.
- Assume linear output unless a nonlinear calibration is provided (no need to memorize specific sensor equations).

Variations & Typical Values:

- Examples: thermocouples (~50 µV/°C), strain gauges (ΔΩ per strain, gauge factor ≈2), pressure transducers (~mV/psi).
- If the full-scale output is very small (e.g. 0–0.05 V), you will almost always need an amplifier to scale it up to the ADC range (e.g. 0–5 V or 0–10 V).

Special Notes:

- On calculators: simply use algebra (no special keys). For example, divide output voltage by sensitivity to find the physical quantity.
- Watch out for offsets. If 0 input ≠ 0 output (e.g. 0 psi→0.50 V), subtract the offset before calculating.

Explanation & Analysis:

In an FE problem, you typically start with a sensor reading and solve for the physical quantity. For example, if a pressure sensor is 0.01 V/psi and reads 0.30 V, you solve

$$0.30 \text{ V} = (0.01 \text{ V/psi}) \times P$$

to get $P = 30$ psi. That 0.30 V is then passed to the amplifier/filter stage. Key pitfalls are ignoring offsets and mixing up units. **Always** write the sensor's equation, include any baseline offset, and solve algebraically before moving to the next step.

K13.T01.S14 – Signal Conditioning (Gain & Filtering)

- **Signal conditioning** means amplifying and filtering the sensor signal so it is in a useful range. In practice, a very small raw signal is boosted and cleaned up.
- Conditioning usually involves an **amplifier** (to increase amplitude) and an **analog filter** (to remove unwanted frequencies).
- **Gain:** If the sensor output spans only a small range, apply a gain G so that the output uses most of the ADC's input range. Mathematically, $V_{\text{out}} = G\,V_{\text{in}}$ (unitless G). For instance, $G = 100$ scales 0–0.05 V to 0–5 V, maximizing ADC use.
- **Filtering:** Typically a low-pass filter removes high-frequency noise and prevents aliasing. Its cutoff frequency f_c is usually set near or below $f_s/2$.
- **Key idea:** Without proper gain, you "waste" ADC resolution; without filtering, out-of-band noise can corrupt the signal.

Exam Handbook Search Cues (Not affiliated with or endorsed by NCEES): amplifier; gain; filter; signal conditioning.

Footnotes:

- For op-amps: noninverting gain $G = 1 + R_2/R_1$; inverting gain $G = -R_2/R_1$ (negative sign indicates phase inversion).
- RC low-pass cutoff: $f_c = 1/(2\pi RC)$. In calculations, enter R in ohms, C in farads, and include 2π.
- Ensure SI units in the calculator: e.g. enter $R = 10 \times 10^3$ Ω as 1e4 and $C = 10$ nF as 10e-9.

Variations & Typical Values:

- Example: If $f_s = 10$ kHz, a safe low-pass cutoff might be ~4–5 kHz.
- Higher-order filters (2nd, 4th order) are rare on the FE; most problems imply a single-pole (RC) response.

Special Notes:

- On calculators: use parentheses carefully. For example, enter 1/(2*pi*R*C).
- If a problem mentions "band-pass" or "high-pass," focus on the low-pass cutoff for aliasing concerns.

Explanation & Analysis:
You set gain so the ADC uses its full range. For example, a 0–0.05 V sensor signal with $G = 100$ becomes 0–5 V into the ADC. That maximizes the count changes. Then filter: if your sensor varies only up to a few kHz, use a low-pass filter to block higher-frequency noise. For instance, with $R = 10$ kΩ and $C = 10$ nF, $f_c = 1/(2\pi \cdot 10^4 \cdot 10^{-8}) \approx 1.59$ kHz. This removes spikes above ~1.6 kHz. In typical problems, you might compute f_c this way or simply note "low-pass filter at X kHz."

K13.T01.S15 – Sampling Theorem (Nyquist Sampling)

Equation Passport: Nyquist Sampling Theorem – minimum sampling rate to avoid aliasing

$$f_s > 2\, f_{\max}$$

- **Name and purpose:** Determines how fast to sample an analog signal for faithful capture. It states that the sampling frequency f_s must be greater than twice the highest signal frequency $f_{\max}$.

- **Equation:** $f_s > 2f_{\max}$.

- **Variables and units:** f_s = sampling rate (Hz), $f_{\max}$ = highest frequency in the analog signal (Hz).
- **Assumptions & scope:** Assumes the signal has no content above $f_{\max}$ (band-limited). Applies to uniform sampling of analog signals.

- **Limit tests:** If $f_{\max} = 0$ (constant signal), any $f_s > 0$ works. As $f_s \to 2f_{\max}$, you reach the threshold of aliasing. If $f_s \gg 2f_{\max}$, you oversample (safer, but more data).

- **Use vs. sibling:** Use this rule when choosing a sampling rate for sensor data. Do not confuse it with Fourier transform formulas – this is a practical time-domain criterion.

- **Common exam traps:** - Missing the factor of 2 (writing $f_s > f_{\max}$ is wrong). - Using the wrong $f_{\max}$ if multiple frequencies exist. - Mixing units (always use Hz).

Exam Handbook Search Cues (Not affiliated with or endorsed by NCEES): Nyquist; sampling rate; aliasing.

Footnotes:

- The handbook defines sampling period T_s where $f_s = 1/T_s$. If given T_s in a problem, invert it.
- If a waveform is specified by frequency (Hz), take that as $f_{\max}$ if no other content is mentioned.
- In strict terms use "≥" (Nyquist rate), but on the exam use > to avoid aliasing.

Variations & Typical Values:

- In time form: $T_s < 1/(2f_{\max})$.
- Audio example: $f_{\max} = 20$ kHz → $f_s > 40$ kHz (hence CDs use 44.1 kHz).
- Very low-frequency example: $f_{\max} = 0.5$ Hz → $f_s > 1$ Hz (you might sample at 5 Hz or more).

Special Notes:

- On calculators: to check Nyquist, compute $2f_{\max}$ and compare to f_s. Calculators cannot handle an inequality directly; you provide a number for $2f_{\max}$ (e.g. 2*150=300).
- If given angular frequency ω (rad/s), convert by $f = \omega/(2\pi)$ first.

Explanation & Analysis:

Nyquist's theorem is fundamental: you must sample at least twice as fast as your fastest signal wiggle. For example, a 200 Hz vibration requires $f_s > 400$ Hz. On the FE, if a question states "A 150 Hz component is present," compute $f_s > 2 \times 150 = 300$ Hz. Sampling slower causes aliasing (see next). Sampling much faster (e.g. 2 kHz for a 200 Hz signal) is fine but usually unnecessary. Always check that your sample rate meets this criterion in Hz.

K13.T01.S16 – Aliasing (Definition)

- **Aliasing:** When a signal is undersampled, high-frequency components masquerade as lower frequencies. In other words, anything above $f_s/2$ "folds" into the sampled data.
- **Where it matters:** Aliasing errors appear in FE problems involving sampling. For example: *"A 500 Hz signal is sampled at 800 Hz. What alias frequency appears?"* The answer is $500 - 800 = -300$ Hz (take absolute 300 Hz) appearing below 400 Hz.
- **Pitfall:** Do not confuse aliasing with quantization error. Aliasing occurs independent of bit depth when $f_s < 2f_{\max}$.
- **Micro-check:** *True or False:* Sampling a 100 Hz signal at 150 Hz will cause aliasing. (True, since 150<200.)

Exam Handbook Search Cues (Not affiliated with or endorsed by NCEES): alias frequencies; undersampling; sample rate.

Footnotes:

- A quick alias formula: $f_{\text{alias}} = |f_{\text{signal}} - Nf_s|$ for some integer N. For basic FE use, if $f_{\text{signal}} < 2f_s$, simply take $|f_{\text{signal}} - f_s|$.
- If $f_{\text{signal}} < f_s/2$, no alias occurs (signal safely below Nyquist).

Variations & Typical Values:

- Example: 500 Hz signal, 800 Hz sampling. Compute $800 - 500 = 300$ Hz (appears as 300 Hz).
- Example: 1200 Hz signal, 800 Hz sampling. Take $N = 1$: $1200 - 800 = 400$ Hz (Nyquist edge).
- With a perfect anti-alias filter, ideally no components above $f_s/2$ remain, eliminating alias (on FE, expect ideal filters unless specified otherwise).

Special Notes:

- On calculators: simply subtract. If you get a negative result, take its absolute value.

- Conceptual check: imagine the frequency spectrum folding over at each multiple of f_s.

Explanation & Analysis:

Aliasing is like a visual alias of a spinning wheel. A high-frequency wiggle shows up as a lower frequency in the sampled data. For example, sampling a 600 Hz signal at 800 Hz yields an apparent 200 Hz signal (600-800 = –200 Hz, take 200 Hz). On the FE, always apply the Nyquist rule to avoid this: if your chosen f_s is too low, compute the difference as above to find the alias frequency. The key to avoiding errors is enforcing $f_s > 2f_{\text{signal}}$.

K13.T01.S17 – A/D Conversion Resolution

Equation Passport: ADC Voltage Resolution – smallest distinguishable step

$$\Delta V = \frac{V_H - V_L}{2^n}$$

- **Name and purpose:** Gives the voltage corresponding to one ADC count (LSB) for an n-bit converter over range $[V_L, V_H]$.

- **Equation:** $\Delta V = (V_H - V_L)/2^n$.

- **Variables and units:** ΔV in volts; V_H, V_L are high/low voltage limits (volts); n = number of bits (integer).

- **Assumptions & scope:** Assumes an ideal linear ADC and uses 2^n in the formula (per handbook). The maximum code $2^n - 1$ corresponds to $V_H - \Delta V$. If $V_L \neq 0$, include it as shown.

- **Limit tests:** If $V_H - V_L = 0$, $\Delta V = 0$ (no span). As n increases, ΔV decreases (finer resolution); as $n \to \infty$, $\Delta V \to 0$.

- **Use vs. sibling:** Use this to find the smallest voltage step per bit. Do not confuse with the conversion formula $V = V_L + N\Delta V$.

- **Common exam traps:**

- Using $2^n - 1$ instead of 2^n (the handbook uses 2^n).
- Ignoring V_L if the range doesn't start at 0.
- Mixing up ΔV (a voltage) with the digital count N.

Exam Handbook Search Cues (Not affiliated with or endorsed by NCEES): resolution; quantization; ADC; least significant bit; bits.

Footnotes:

- Many references define $\Delta V = (V_H - V_L)/(2^n - 1)$. The exam handbook's version uses 2^n, so treat the top count $2^n - 1$ as giving $V_H - \Delta V$.
- Units: If $V_H = 5$ V and $V_L = 0$, ΔV is in volts ($5V/2^n$). Keep units consistent (e.g. use V).
- For a unipolar 0–V_{ref} ADC: $\Delta V = V_{\text{ref}}/2^n$.

Variations & Typical Values:

- Example: 10-bit, 0–10 V range: $\Delta V = 10/1024 \approx 0.00977$ V (9.77 mV).
- 12-bit, ±5 V range: $\Delta V = 10/4096 \approx 0.00244$ V (2.44 mV).
- If $V_L = 1$ V, $V_H = 6$ V, $n = 8$: $\Delta V = 5/256 \approx 0.01953$ V.

Special Notes:

- On calculators: compute 2^n with the exponent key (e.g. 2^8 = 256).
- To convert a reading N to voltage, use $V = V_L + N\Delta V$. Enter it as V_L + N*(V_H - V_L)/2^n.

Explanation & Analysis:

This formula quantifies ADC precision. For instance, a 12-bit ADC over 0–5 V has $\Delta V = 5/4096 \approx 0.00122$ V. Any change smaller than ~1.22 mV won't affect the digital output. That's why amplifying small signals is crucial. On the FE, you might be given n, V_H, V_L and asked for ΔV. You simply plug into $\Delta V = (V_H - V_L)/2^n$. As a sanity check, multiply ΔV by 2^n to verify you get the full-scale span $(V_H - V_L)$.

Topic 02 - Control Systems

A control system uses feedback to make a process behave as desired. On the FE Mechanical exam, you may see block-diagram problems where you must derive the transfer function or compute steady-state error. These questions typically ask you to find the output *Y(s)* for a given input *R(s)*, determine the effect of a disturbance *L(s)*, or choose controller gains to meet a specification. In this topic, we focus on **block-diagram representation** of feedback loops, including PID controller blocks, plant (process) dynamics, and feedback elements. Understanding this representation is key to solving exam problems by following the signal flow through the system. You will learn to write the closed-loop transfer function of a standard feedback loop and identify each component's role.

K13.T02.S01 – Block Diagram of Feedback Control System

Principle: A feedback control loop is often drawn as a block diagram with a summing junction. For example, the reference input *R(s)* is compared to the feedback signal, producing an error *E(s)*. The error passes through the **controller** $G_1(s)$, then through the **plant (process)** $G_2(s)$. The plant output *Y(s)* may be measured by a sensor with transfer function *H(s)*, which feeds back to the subtracting junction (negative feedback). This **classical negative-feedback loop** is a linear time-invariant model.

Key points:

- The **controller block** (e.g. PID controller) adjusts its output based on the error signal to drive the plant. (On the exam, $G_1(s)$ might be given or asked for.)
- The **plant block** $G_2(s)$ represents the process dynamics you control (e.g. mechanical system, chemical reactor).
- The **feedback block** *H(s)* models any sensor or feedback dynamics (often unity, *H(s)=1*).
- At the **summing junction**, the feedback term $H(s)Y(s)$is subtracted from $R(s)$, giving the error $E(s) = R(s) - H(s)Y(s)$.

By following the arrows (using Laplace-transformed variables with *s* as complex frequency), you can write equations that relate *Y(s)* to *R(s)* and any disturbance *L(s)*. The **closed-loop transfer function** from reference *R(s)* to output *Y(s)* is given by a formula (see Equation Passport below). This transfer function is central to determining how the system responds to inputs on the exam.

Diagram Passport: *Feedback Control Loop Diagram – visualizes signal flow in a closed-loop system.* Inputs and outputs are labeled at the arrows. Each block shows a transfer function. Read from left to right: start at *R(s)*, go to summing junction (compare to feedback), then through $G_1(s)$ and $G_2(s)$ to get *Y(s)*. The feedback path returns *H(s)Y(s)* to the summing node. On the exam, students trace the diagram to write equations. **Common misreads:** forgetting the minus sign on the feedback path, confusing the order of blocks, or assuming *H(s)=1* when it isn't.

Equation Passport: Closed-Loop Transfer Function

Closed-Loop Transfer Function – computes output *Y(s)* for a given reference *R(s)* in a standard feedback system.

$$T(s) = \frac{Y(s)}{R(s)} = \frac{G_1(s)\,G_2(s)}{1 + G_1(s)\,G_2(s)\,H(s)}.$$

Professional equation: $T(s) = \frac{Y(s)}{R(s)} = \frac{G_1(s)\,G_2(s)}{1+G_1(s)\,G_2(s)\,H(s)}$. This assumes linear, time-invariant components and negative feedback.

Variables & units:

- $G_1(s)$, **Controller Transfer Function** (e.g. PID controller), unitless ratio.
- $G_2(s)$, **Plant Transfer Function**, unitless ratio.
- $H(s)$, **Feedback Transfer Function**, unitless (often $H(s) = 1$).
- s, Laplace variable [rad/s].
- $Y(s), R(s)$, output and reference in Laplace domain (their units depend on system, e.g. displacement [m]).

Assumptions/scope:

- **Linear, time-invariant** system, single-loop negative feedback.
- Summing junction defined such that error $E = R - H\,Y$.
- Input/output signals are Laplace-transformed, $s = \sigma + j\omega$ (analyze at steady state or frequency).
- All dynamics lumped into blocks (no hidden delays unless included in G_1 or G_2).
- *Included:* classical feedback, PID controllers. *Excluded:* feedforward-only schemes, nonlinearities.

Limit tests: If $G_1G_2H \to 0$ (controller off), then $T(s) \to G_1G_2$. If $G_1G_2H \to \infty$ (very high loop gain), then $T(s) \to 1/H(s)$ (the loop tries to enforce output s.t. $R = H\,Y$).

Use vs siblings: Use this instead of an open-loop formula when there is feedback. *Do not* use if system is open-loop (no feedback summing junction).

Common exam traps:

- Forgetting the feedback term: some students write $T(s) = G_1G_2$ and miss the $1 + G_1G_2H$ in the denominator.
- Confusing sign of feedback: ensure the sign in the summing node matches the equation (here it's negative feedback).
- Mixing steady-state gain K with transfer function (in a PID form, K_c appears in $G_1(s)$, see below).

Footnotes: *Variables are in Laplace domain with s; time units are seconds*. By default assume *negative feedback* and all blocks have compatible units. If a problem defines $H(s) = 1$ (unity feedback), substitute $H(s) = 1$. Most FE problems use steady-state or simple frequency analysis with this $T(s)$.

Controller Form (PID)

A common controller block is the **PID controller**. Its transfer function in series form is:

$$G_1(s) = K_c\left(1 + \frac{1}{T_i s} + T_d s\right),$$

where K_c is the controller gain, T_i the integral time, and T_d the derivative time. This formula is *typed into calculators* by computing each term (e.g. if $T_d = 0$, it's PI control). Watch units: T_i and T_d are in seconds, K_c unitless gain. A typical trap is using *Ki* instead of *Ti*. (Some references use $K_i = K_c/T_i$; if given, convert accordingly.)

Exam Handbook Search Cues

Search the exam handbook (digital copy) for key phrases. For this subtopic, useful keywords include **"control system block diagram," "transfer function," "feedback loop," "closed-loop," "PID controller,"** and **"steady-state error."** These terms will lead you to the relevant section. They are *not* chapter titles in the handbook; use the search function to jump to definitions or formulas of interest.

Footnotes on Notation

- $G_1(s)$ often denotes the **controller**; on the exam, it could be labeled *C(s)* or just "Controller."
- $G_2(s)$ denotes the **plant** (process). Ensure you match what the problem calls "plant" or "process."
- If the problem says *unity feedback*, set $H(s) = 1$. Otherwise, $H(s)$ may represent a sensor gain or secondary dynamics.
- We assume **negative feedback** as drawn. If a question gives a summing sign with the minus input arrow, use the formula above.
- Results in FE problems are usually final-value (steady-state) errors or gains; use the Final Value Theorem if needed.

Variations and Typical Forms

- **Unity-Feedback Case:** If $H(s) = 1$, the formula simplifies to $T(s) = \frac{G_1 G_2}{1+G_1 G_2}$. Many exam problems assume unity feedback to simplify calculations.
- **Open-Loop Transfer Function:** Defined as $L(s) = G_1(s)G_2(s)H(s)$. The characteristic equation is $1 + L(s) = 0$ (roots give stability). FE problems sometimes ask for *gain margin* or *phase margin* which are derived from $L(s)$.

Steady-State Error Table: For a **unity (1) negative-feedback** system with open-loop transfer $L(s) = G_1(s)\,G_2(s)$, the steady-state error to the "standard" test inputs depends mainly on the system **type**, where: **Type = number of poles at the origin in** $L(s)$(i.e., how many pure integrators $1/s$appear in the open loop). On FE-type problems, you typically compute a **static error constant** (a DC/low-frequency limit) and then read off the steady-state error: $K_p = \lim_{s\to 0} L(s), K_v = \lim_{s\to 0} sL(s), K_a = \lim_{s\to 0} s^2 L(s)$. For **unit** inputs, the standard results are:

Unit step: $e_{ss} = \frac{1}{1+K_p}$

Unit ramp: $e_{ss} = \frac{1}{K_v}$

Unit parabolic (acceleration): $e_{ss} = \frac{1}{K_a}$

Rule of thumb: if the relevant constant is **0** ⇒ $e_{ss} = \infty$, and if it's ∞⇒ $e_{ss} = 0$.

System type (integrators in $L(s)$)	**Unit step $r(t) = 1$**	**Unit ramp $r(t) = t$**	**Unit parabolic $r(t) = t^2/2$**
Type 0 (0 poles at $s = 0$)	$\frac{1}{1+K_p}$	∞	∞
Type 1 (1 pole at $s = 0$)	0	$\frac{1}{K_v}$	∞
Type 2 (2 poles at $s = 0$)	0	0	$\frac{1}{K_a}$

Note (matches common "$1/K$" shortcuts): Some quick tables write $e_{ss} = 1/K$. In that shorthand, K means **the applicable** static error constant for the input you're using: K_p for step, K_v for ramp, K_a for parabolic.

- **Typical values:** Controller gains K_c are often chosen to achieve a desired steady-state error or damping. Plant dynamics *G₂(s)* in FE problems are usually simple (e.g. first-order $\frac{K}{\tau s+1}$ or second-order).

Special Notes on Calculators

When entering transfer functions on approved calculators (Casio fx-115, etc.), use parentheses carefully. For example, to evaluate $T(10)$ if $T(s) = 1/(s+5)$, enter it as 1/(10+5) (not 1/10 + 5).

However, FE questions rarely require numeric inversion of Laplace functions; focus on algebraic forms.

Explanation & Analysis: To solve problems, **first sketch the block diagram** and label each block's transfer function. Then write the summing-junction equation:

$$E(s) = R(s) - H(s)\,Y(s).$$

Next, express $Y(s) = G_1(s)\,G_2(s)\,E(s)$. Substitute $E(s)$ into this to eliminate E, giving

$$Y(s) = G_1G_2(R - H\,Y) \quad \Rightarrow \quad Y(s)(1 + G_1G_2H) = G_1G_2\,R(s).$$

Solving, $Y/R = \frac{G_1G_2}{1+G_1G_2H}$. This matches our passport formula.

Each symbol has a role: $G_1(s)G_2(s)$ in the numerator shows **how controller and plant multiply input**, while $1 + G_1G_2H$ in denominator shows the feedback loop. If you get an error, check units of s (rad/s) and that $H(s)$ was correctly placed. Finally, plug in any numeric values and simplify. For steady-state error, use Final Value Theorem: $e_{ss} = \lim_{s\to 0} s\,E(s)$. Common pitfalls: skipping the "+1" in denominator or mixing up *poles* of G_1G_2 (which determine system **type**). Always double-check each block's formula and sign at the summing node.

We assume the loop is **causal and stable**. If any pole in $1 + G_1G_2H = 0$ has Re[s]≥0, the loop is unstable (rare in simple FE problems).

On the FE exam, "control error = reference – feedback" is standard. If a diagram shows *feedback added* instead of subtracted, the closed-loop formula becomes $T = G_1G_2/(1 - G_1G_2H)$; carefully read the diagram.

Final Value Theorem: If stable, $\lim_{t\to\infty} y(t) = \lim_{s\to 0} sY(s)$. This applies only if $sY(s)$ has no poles in the right-half plane.

K13.T02.S02 – Open-Loop vs Closed-Loop Control Systems

- **Open-loop control:** The controller's output is not fed back for comparison. The system acts on the input (reference) without checking the actual output, so disturbances or model errors aren't corrected. (Example: A timed sprinkler system waters plants for a fixed duration regardless of soil moisture).
- **Closed-loop (feedback) control:** The system senses the output and feeds it back for comparison with the reference input. The resulting difference (error) drives the controller to minimize the deviation. In a *negative feedback* loop the sensor signal is subtracted from the reference to form the error E(s) = R(s) – Y(s). (Example: A thermostat adjusts heater output based on the measured room temperature.)
- **Key idea:** Feedback makes the system **self-correcting**. By continuously adjusting for disturbances or uncertainty, closed-loop systems maintain the output near the desired value. Open-loop systems cannot automatically compensate for changes once running.

Definition (Open-loop control): A system in which the controller output does not use feedback from the measured output. The control action depends only on the input command, not on the actual output.

- **Exam impact:** Usually appears in questions asking to identify whether feedback is present. An open-loop system has no feedback path.

- **Pitfall:** Do not confuse open-loop with "non-feedback". Some systems may have internal controls (like feedforward) but still no actual feedback.

- **Micro-check:** *True or False:* An irrigation timer that always runs for 15 minutes regardless of soil moisture is an open-loop control. (True.)

Definition (Closed-loop control): A system that uses feedback of the output to automatically adjust the input. The output is compared to the reference, and the resulting error drives the controller.

- **Exam impact:** Essential for any problem with summing junctions or sensors. Recognize block diagrams with a feedback arrow as closed-loop.

- **Pitfall:** Watch signal polarity: in negative feedback, the output is subtracted from the reference. Confusing this sign can flip stability assessments.

- **Micro-check:** *True or False:* A cruise control that adjusts throttle based on actual speed is a closed-loop system. (True.)

Visual (Block Diagram): A classical negative-feedback control loop is shown below. The reference input R(s) is compared (subtracted) with the measured output Y(s) (via transfer H(s)); the error E(s) drives the controller $G_1(s)$ and plant $G_2(s)$. In an *open-loop* system, the feedback path (H(s)) is absent, so the controller only sees R(s).

- *Diagram Description:* Reference R enters a summing circle (with "+" for R and "–" from the output). The error E goes through controller $G_1(s)$ and plant $G_2(s)$ to produce output Y. A branch from Y feeds back (through H(s)) into the summing circle.

Exam Handbook Search Cues (Not affiliated with or endorsed by NCEES): "open-loop control," "closed-loop control," "feedback control," "control system block diagram," "transfer function." These keywords will help you quickly locate relevant formulas or examples of feedback systems in the exam handbook.

Footnotes:

- In a *negative-feedback* loop, the summing junction subtracts Y from R: $E = R - Y$. (Check sign: if you accidentally add Y instead, you get positive feedback, which is rare on FE.)
- We assume linear, time-invariant systems. If the plant is non-linear or has time-varying gain, those cases are usually excluded in basic FE problems.
- The signal H(s) often equals 1 (unity gain feedback) unless otherwise stated; if H(s)≠1, the formulas change.

Variations and Related Concepts:

- *Feedforward control* – a variant where the controller anticipates disturbances based on a model, but it does **not** use feedback from the output (still open-loop in FE context).
- *Multi-loop systems* – some systems have cascaded or multiple feedback loops. On the FE, focus on analyzing one loop at a time.
- *Sensors and actuators* – physical devices (thermistors, flow meters, valves) implement H(s), $G_1(s)$, etc., but the exam treats them abstractly as block gains/transfer functions.

Special Notes: No calculator steps are needed specifically for this concept beyond normal algebra. Just remember that identifying an open vs closed loop is a *recognition* step, not a computation. Check your block diagram carefully: the presence of a feedback arrow from Y to the summing node (usually with a "–" sign) means closed-loop.

Explanation & Analysis: In FE-type problems, an open-loop system is one where the output does not affect the input. For example, a mixer that runs for a set time without checking mixture quality is open-loop. Closed-loop systems, by contrast, compare output to a reference and adjust. In the block diagram, the controller G(s) gets input $E(s) = R(s) - Y(s)$. The FE handbook shows a standard negative-feedback loop: $G_1(s)$ (controller), $G_2(s)$ (plant), $H(s)$ (sensor) with $Y(s)$ subtracted from $R(s)$. The combined open-loop transfer function is $G_{OL}(s) = G_1(s)G_2(s)H(s)$. A common mistake is forgetting to include the feedback branch in the loop: for closed-loop, you must account for both forward and feedback paths. In an open-loop case, set $H(s) = 0$ or simply remove the feedback arrow, so that $Y(s)$ does not affect $E(s)$.

K13.T02.S02 – Unity Feedback Control Systems

Equation Passport: *Closed-Loop Transfer Function (Unity Feedback)* – computes the output ratio Y/R when the output is fed back directly (gain = 1) to the input summing junction.

$$T(s) = \frac{Y(s)}{R(s)} = \frac{G(s)}{1 + G(s)}.$$

Variables:

- $G(s)$: the *open-loop transfer function*, which is the product of forward path gains (controller + plant). It is dimensionless (ratio of output to input in Laplace form).
- $T(s)$: the *closed-loop transfer function* (output-to-input ratio). Also dimensionless.

Assumptions/Scope:

- Unity feedback means the feedback path has gain 1 (i.e. $H(s) = 1$).
- Negative feedback is assumed. (If the feedback were positive, formula changes and stability is lost.)
- Linear, time-invariant systems with zero initial conditions.
- Focus on behavior under constant inputs (no additional dynamics like nonlinearity).

Limit Tests (Sanity Checks):

- As $G(s) \to 0$ (very low gain), $T(s) \approx G(s)$ (system hardly changes input).
- As $G(s) \to \infty$ (very high gain), $T(s) \to 1$ (output nearly equals reference – ideal tracking).
- If $G(s) = 0$, then $Y(s) = 0$ (no output from no gain).
- If $G(s) = -1$, denominator zero (unstable loop – rarely given on FE).

Use vs. Sibling Equations:

- Use this closed-loop formula **instead of** the raw forward transfer $G(s)$ when a feedback loop is present.
- If *no* feedback or $H(s) \neq 1$, you'd use a different relation (e.g. $Y/R = G(s)/\big(1 + G(s)H(s)\big)$ for general feedback).

Common Exam Traps:

- Forgetting the "+1" in the denominator: omitting it gives the open-loop gain by mistake.
- Mixing up $G(s)$ vs $T(s)$: remember $T(s)$ is what multiplies $R(s)$ to give $Y(s)$.
- Misinterpreting unity feedback: if the problem statement says "feedback loop" without specifying $H(s)$, it's safe to assume $H(s) = 1$ unless otherwise stated.
- Assuming stability without check: even with unity feedback, check if the denominator $1 + G(s)$ can go to zero (poles in right-half plane).

Exam Handbook Search Cues (Not affiliated with or endorsed by NCEES): "unity feedback," "closed-loop transfer function," "feedback loop," "steady-state error (unity feedback)." These terms lead you to the standard closed-loop formulas and error analysis tables in the handbook.

Footnotes:

- In the official handbook, $G(s)$ might denote *either* open-loop or closed-loop transfer function. Here we use $G(s)$ for the *forward-path* (open-loop) gain, and $T(s)$ for the closed-loop result.
- We assume ideal summing with no offset. In reality, sensors and electronics might add biases, but FE problems ignore those.

Variations, Related Forms:

- *Non-unity feedback:* If the feedback path has transfer $H(s) \neq 1$, the formula becomes $T(s) = G(s)/\big(1 + G(s)H(s)\big)$. (Not common on FE, but good to know.)

- *Error transfer function:* The steady-state error can be found from $E(s)/R(s) = 1/\big(1 + G(s)\big)$ for unity feedback. The handbook provides tables for step, ramp, acceleration errors by system type.

- *Type of system:* For a unity system with pure gain $G(s) = K/s^n$, recall the "system type" (number of integrators) to determine if steady-state error is finite or zero for step/ramp inputs.

Special Notes: To enter this in a calculator, simply compute $G(s)$ then form $\frac{G}{1+G}$ carefully. On a TI-36X or Casio, use parentheses: e.g. G/(1+G). Check that you don't accidentally square operators.

Explanation & Analysis: When the output is fed back directly (unity gain) to the summing node, the closed-loop transfer function is $T(s) = G(s)/\big(1 + G(s)\big)$. On exam block diagrams, you will see R(s) – Y(s) into a single gain block labeled G(s) (or a series of blocks whose product is G(s)). The FE handbook illustrates a unity-feedback loop with blocks R, E, G, Y. To derive $T(s)$ from first principles: let $E(s) = R(s) - Y(s)$, and $Y(s) = G(s)\,E(s)$. Substitute to get $Y = G(R - Y)$, so $Y + GY = GR$, hence $Y/R = G/(1 + G)$.

Each symbol represents a physical meaning: $R(s)$ is the reference (input command), $E(s)$ the error, $Y(s)$ the output. The gain $G(s)$ has units of (output/input), so $T(s)$ is dimensionless. A common student mistake is to treat $G(s)$ and $T(s)$ interchangeably; always check if the problem asks for the *closed-loop* response (then use T) or the *open-loop* gain (just G).

For steady inputs (like a step), high DC gain $G(0)$ drives the output closer to the reference: indeed, $\lim_{s\to 0} T(s) = G(0)/\big(1 + G(0)\big) \to 1$ if $G(0)$ is large. This matches the *limit tests* above. Conversely, if $G(s)$ is small, $T(s) \approx G(s)$ so the feedback does little (approaching an open-loop response). Always double-check units (e.g. rad/s for Laplace frequency) and signs (the "+" in the denominator is from negative feedback).

By using the unity-feedback formula, you can quickly find how the system tracks the input. For example, if $G(s) = K/(\tau s + 1)$ (a first-order plant with gain K), then $T(s) = \frac{K/(\tau s+1)}{1+K/(\tau s+1)} = \frac{K}{\tau s+1+K}$. On the exam, you might plug such $T(s)$ into an inverse Laplace to get time response, or use final value theorem to find steady error. Throughout, remember the **goal of unity feedback**: minimize steady-state error and improve stability by making $G(s)$ large where needed. Check the handbook for the standard error table and margin formulas as needed, and practice typing expressions exactly into your calculator.

Topic 03 - Dynamic System Response

Dynamic system response refers to how a system's output changes over time after a sudden input or disturbance. In the FE Mechanical Exam, this topic often appears in control-system questions: for example, determining how a sensor or process responds to a step input. Understanding first-order response helps you predict the rise/decay behavior and compute quantities like time to a certain percentage of the final value. A typical exam problem might present a first-order transfer function or ODE and ask for the output $y(t)$ after a step input, the time constant τ, and the steady-state gain.

K13.T03.S01 – First-Order System Response

Principle Introduction:

- A first-order dynamic system is described by a linear ODE such as $\tau \frac{dy}{dt} + y = K\,u(t)$, where $u(t)$ is the input (often a step) and $y(t)$ is the output.

- After a step input of magnitude M at $t = 0$, the output $y(t)$ changes exponentially (either rising or decaying) toward its new steady value.

- The parameter τ is the **time constant** (in seconds), indicating how fast the system responds. The parameter K is the **steady-state gain** (output change per unit input).

- Physically, many instruments and processes (e.g. a thermometer, a first-order RC circuit, or a simple chemical reactor) exhibit this behavior: they don't jump instantly but instead approach the new value gradually with an exponential curve.

Equation Passport – First-Order Step Response:

- **Name & Purpose:** *First-Order System Step Response – computes the time history of a first-order system's output after a step input.* It is used to find how quickly the output reaches its final value.

- **Professional Equation:**

$$y(t) \;=\; y_0 \;+\; K\,M\left(1 - e^{-t/\tau}\right).$$

Here y_0 is the output at $t = 0$, M is the step input magnitude, K is gain, and τ is the time constant. This form assumes a step applied at $t = 0$. (When $y_0 = 0$, it simplifies to $y(t) = KM\left(1 - e^{-t/\tau}\right)$.)

- **Variables & Units:**

- $y(t)$: output at time t. (Units: same as output, e.g. volts, °C, etc.)
- y_0: initial output (value at $t = 0$). Same units as y.
- K: steady-state gain (dimensionless or in output/input units). It represents the final change in output per unit input.
- M: step input magnitude (units of input; e.g. input voltage if the system is a circuit).
- t: time since step (seconds).
- τ: time constant (seconds). Defines the speed of response. (Larger τ = slower response.)

- **Assumptions & Scope:**

- **Linear, time-invariant, single-pole system:** The formula applies when the system is well-modeled by one first-order term (no higher-order dynamics or oscillations).

- **Zero initial stored energy aside from y_0:** Usually assume zero initial rate (so only y_0 matters at $t = 0$).

- **Step input at $t = 0$:** This derivation is for an ideal step change at time zero.

- **No coupling to other dynamics:** If a delay (dead time) exists, the simple formula shifts by the delay (not covered here).

- **Included/Out of Scope:** Included: predicting output vs. time, finding time constants. Out of scope: second-order effects, oscillations, and complex poles (use second-order formulas instead if system has two poles).

- **Limit Tests:**

- As $t \to 0^+$, $y(t) \to y_0$ (the output starts at its initial value)
- As $t \to \infty$, $y(t) \to y_0 + KM$ (the output approaches the final steady value).

- **Use vs. Sibling Equations:** Use this equation instead of a second-order step-response formula when the system has only one energy storage (one pole). If the system shows no overshoot and can be modeled by $\tau dy/dt + y = Ku$, this is the right form.

- **Common Exam Traps:**

- **Forgetting initial condition:** Not including y_0 shifts can cause mistakes (often $y_0 = 0$ in problems, but check!).

- **Sign of exponent:** Remember it's $\exp(-t/\tau)$. Mixing up sign yields an unphysical growth/decay.

- **Unit mix-ups:** Ensure τ and t use same time units.

- **Forgetting gain units:** If K has units (e.g. °C/V), include them; otherwise treat K as dimensionless.

Exam Handbook Search Cues (Not affiliated with or endorsed by NCEES): *step response, first-order, time constant, steady-state gain, transfer function.* (These keywords help locate relevant formulas in the exam handbook.)

Footnotes:

- A common convention is to take $y_0 = 0$ for a "deviation variable" form; then $y(t) = KM\left(1 - e^{-t/\tau}\right)$.
- The gain K may be written as the ratio of output change to input change (e.g. $\Delta y/\Delta u$).
- τ (time constant) is the time it takes for the output to reach about 63.2% of its final change $\Delta y = KM$.

Variations, Related Forms, Typical Values:

- **Differential Equation Form:** The ODE $\tau \frac{dy}{dt} + y = K\,M$ (for a step of size M) yields the same solution. You can solve it by standard methods (see Equation Passport).

- **Alternate expression:** Sometimes written as $y(t) = y(\infty) - [y(\infty) - y_0]e^{-t/\tau}$, where $y(\infty) = y_0 + KM$ is the final value.

- **No overshoot:** Unlike underdamped 2nd-order systems, a first-order response never overshoots the final value (monotonic rise/decay).

- **Time constant rule of thumb:** At $t = \tau$, $y(t) \approx y_0 + 0.632\,(KM)$. At $t \approx 5\tau$, $y(t)$ is over 99% of the way to its final value.

- **Typical gain values:** In many systems K is order unity. If $K < 0$, the output may invert (but formula form is identical).

Special Notes:

- To enter the exponential in a calculator, use the built-in e^x or exp() key. For example, on a TI-36X, compute exp(-t/τ). Enclose t/τ in parentheses.
- If computing percent of final value, note that $\frac{y(t)-y_0}{KM} = 1 - e^{-t/\tau}$. Ensure you compute the fraction properly to avoid order-of-operations errors.

Explanation & Analysis:

This formula is used to find how the output of a first-order system responds over time when the input jumps to a new level. For example, if a heater's control system has a first-order temperature response (with time constant τ), and you step the input voltage by M, this equation tells you the temperature rise over time. On the FE exam, you might be given the transfer function or ODE of a sensor or process and asked for $y(t)$ or the time it takes to reach a certain percentage of the final value. The key idea is that first-order systems change at a rate proportional to their distance from the final value, leading to an exponential approach.

Term-by-term Analysis: In $y(t) = y_0 + KM\left(1 - e^{-t/\tau}\right)$, the term y_0 is the initial output. The product KM is the total change in output as $t \to \infty$ (final minus initial). The exponential term $e^{-t/\tau}$ causes a gradual change: at $t = 0$, $e^{-0} = 1$ so $y = y_0$; as t increases, $e^{-t/\tau}$ decreases and y moves towards $y_0 + KM$. Here, τ (in seconds) sets the speed: smaller τ means the exponential decays faster. The units match: if KM has units of output (same as y), then everything is consistent. A common pitfall is mixing up K units or forgetting the minus sign in the exponent.

In summary, the first-order step-response equation is a fundamental tool for predicting time-domain behavior of simple control systems. It tells you that the output exponentially approaches the final value with time constant τ. On exam day, quickly identify if a system is first-order (one energy storage) and apply this formula. Always check initial conditions (y_0) and use consistent units.

K13.T03.S02 – Second-Order System Response (Underdamped Mass–Spring–Damper or RLC)

Principle (Key ideas): A standard underdamped second-order system has a Laplace-domain transfer function

$$\frac{Y(s)}{R(s)} = \frac{K\,\omega_n^2}{s^2 + 2\zeta\omega_n\, s + \omega_n^2},$$

where $K$is the steady-state gain (often $= 1$for normalized systems), $\omega_n$is the undamped natural frequency, and $\zeta$is the damping ratio. For $\zeta < 1$the response is underdamped and oscillatory; $\zeta = 1$is critically damped (no oscillation and fastest settling); and $\zeta > 1$is overdamped (no oscillation but slower settling). Key response features for a unit step input are determined by ζ and ω_n:

- **Natural frequency (ω_n):** In a mass-spring-damper, $\omega_n = \sqrt{k/m}$. In a series RLC circuit, $\omega_n = 1/\sqrt{LC}$. (Units: rad/s.)
- **Damping ratio (ζ):** For a damper c in mass–spring, $\zeta = c/\left(2\sqrt{km}\right)$. For RLC, $\zeta = R/(2)\sqrt{C/L}$. (Dimensionless.) Values $0 < \zeta < 1$ give oscillatory decay.
- **Damped oscillation frequency (ω_d):** When $\zeta < 1$, the output oscillates with frequency $\omega_d = \omega_n\sqrt{1-\zeta^2}$. The oscillation period is $T = 2\pi/\omega_d$.
- **Percent overshoot (%OS):** The amount the first peak exceeds steady state is

  Smaller ζ means larger overshoot. (If ζ≥1, overshoot = 0.)
- **Settling time (2% criterion):** Time to stay within 2% of final value is
  $T_s \approx \frac{4}{\zeta\,\omega_n}$.
  Higher damping or frequency means faster settling.

These formulas let you quickly answer FE questions about second-order step responses. For example, given $\zeta = 0.5$ and $\omega_n = 10$ rad/s, you can compute %OS, peak time $t_p = \pi/\omega_d$, and T_s using the above relationships.

Exam Handbook Search Cues (Not affiliated with or endorsed by NCEES): When using the exam handbook, look up keywords like **"damping ratio," "natural frequency," "percent overshoot," "settling time,"** or **"logarithmic decrement."** (These are the terms under which relevant equations and definitions appear in the exam reference material.)

Footnotes (Nuances)

- *Units:* ω_n and ω_d are in rad/s. Damping ratio ζ has no units. Percent overshoot is a percentage. Settling time uses seconds.
- *Normalization:* The %OS and T_s formulas assume a **unit-step input** (or normalized input) and starting from rest.
- *Assumptions:* Formulas above apply only to **linear, time-invariant** 2nd-order systems with zero initial condition and no external feedback (i.e., the simple spring–mass–damper or series RLC form).
- *Range:* The %OS formula only holds for $0 < \zeta < 1$. For $\zeta \geq 1$, there is no oscillation or overshoot.
- *Oscillation vs. decay:* If $\zeta \ll 1$ (light damping), expect many oscillations and large overshoot. If ζ approaches 1, oscillations vanish and response is sluggish.

Variations & Related Forms

- **Critical/Overdamped cases:** If $\zeta = 1$, the system is critically damped (fastest non-oscillatory response; %OS = 0). If $\zeta > 1$, it's overdamped (slow, no oscillation; often negligible %OS).
- **Oscillation period:** You may also see $T = 2\pi/\omega_d$ for the oscillation period (time between successive peaks).
- **5% criterion:** Some texts use a 5% settling time ($\sim T_{s,5\%} = 3/(\zeta\omega_n)$). Check exam cue: FE uses 2% by convention.
- **Logarithmic decrement:** An alternative measure of damping is the logarithmic decrement δ, defined by $\delta =$

$\frac{1}{n}\ln(x_k/x_{k+n}) = \frac{2\pi\zeta}{\sqrt{1-\zeta^2}}$ for successive peaks. (Rarely needed on the exam.)

- **Typical magnitudes:** Many mechanical systems have ζ in the range 0.1–0.3 (noticeable oscillations) or up to 0.7 (moderate overshoot). Natural frequencies ω_n depend on stiffness/mass; there's no single "typical" value except "higher ω_n → faster response."

Special Notes (Calculator Tips)

- **Percent overshoot:** To compute $100e^{-\zeta\pi/\sqrt{1-\zeta^2}}$ on exam calculators, use the natural-exponential and square-root keys. For example, enter EXP(-ζ*π/√(1-ζ^2))*100. Make sure your calculator is in radian mode (though no trig here except π). On TI calculators, use the e^x key or 2nd LN sequence; on Casio, use SHIFT+e^x; on HP, use the e^x function.
- **Settling time:** Enter 4/(ζ*ω_n) directly (all models have fraction and multiplication). No hidden functions needed.
- **Avoiding mistakes:** Always use $\boldsymbol{\pi}$ from the calculator, not 3.14. Use the natural log (LN) key if you ever compute log-decrement by hand (though %OS formula uses e^ directly). Verify that ζ is dimensionless (don't accidentally plug in a percentage or a fraction out of 100 incorrectly).

Explanation & Analysis

For an underdamped step response, **each symbol** carries physical meaning: ω_n is how "stiff" or "quick" the system is (larger ω_n → faster oscillations and quicker settling), while ζ represents friction or resistance (larger ζ → more damping, less overshoot). The **%OS formula** $100e^{-\zeta\pi/\sqrt{1-\zeta^2}}$ reflects that larger damping (ζ) causes the exponential decay envelope to fall faster, reducing overshoot. The **settling time** $4/(\zeta\omega_n)$ shows that raising ζ or ω_n speeds up settling.

On exam day, you might see a spring–mass system or RLC circuit with given parameters. *First*, derive ω_n and ζ from those parameters. *Next*, decide if the system is underdamped (if yes, you can use oscillatory formulas). *Then* plug ζ and ω_n into the standard formulas:

- **Peak time:** $t_p = \pi/\left(\omega_n\sqrt{1-\zeta^2}\right)$. (This is when the first maximum occurs.)
- **Damped frequency:** $\omega_d = \omega_n\sqrt{1-\zeta^2}$.
- **Percent overshoot:** $\%OS = 100e^{-\zeta\pi/\sqrt{1-\zeta^2}}$. Beware: this gives a **percentage**, not a fraction.
- **2% settling time:** $T_s = 4/(\zeta\omega_n)$. Use rad/s for ω_n to get seconds.

Example process: *"We have a mass–spring–damper:* $m = 2kg$, $k = 18N/m$, $c = 4N \cdot s/m$. *Compute* $\omega_n = \sqrt{k/m} = \sqrt{(18/2)} = 3rad/s$. *Damping ratio* $\zeta = c/(2\sqrt{km}) = 4/(2\sqrt{2}\cdot 18) \approx 0.33$. *Since ζ<1, the system oscillates. Then* $\omega_d = 3\sqrt{(1-0.33^2)} \approx 2.82rad/s$, *peak time* $t_p = \pi/2.82 \approx 1.11s$, *overshoot* $100e^{-0.33\pi/\sqrt{(1-0.33^2)}} \approx 18\%$, *and settling time* $4/(0.33\cdot 3) \approx 4.04s$*."*

Pitfalls to watch: Mixing units (e.g. if you mistakenly use ω_n in Hz instead of rad/s, all times will be wrong). Confusing *fractional overshoot* with percentage (remember the formula result times 100). Using the wrong formula for overdamped/critically damped cases (if ζ≥1, skip these formulas and note %OS=0, response is a slow exponential). Finally, don't forget that the formulas assume a **unit step**: if the input magnitude isn't 1, scale the output peak accordingly but the %OS and time metrics stay the same.

By internalizing the transfer function form and these response formulas, you can quickly diagnose any second-order system question on the FE Mechanical exam and compute answers with confidence. Always double-check ζ and ω_n from the given parameters before plugging into the equations.

Equation Passport: Standard Second-Order Transfer Function

Name & Purpose: *Second-order system transfer function* – relates input $R(s)$ to output $Y(s)$ for a damped oscillator. Use it to identify ζ and ω_n from a given system model.
Equation:

$$\frac{Y(s)}{R(s)} = \frac{K\,\omega_n^2}{s^2 + 2\zeta\omega_n\, s + \omega_n^2}.$$

Variables & Units:

- K: steady-state gain (unitless).
- ζ: damping ratio (unitless, $0 < \zeta < 1$ for underdamped).
- ω_n: natural frequency (rad/s).
- s: Laplace variable (rad/s).

Assumptions & Scope: Valid for *linear, time-invariant* 2nd-order systems. Assumes zero initial conditions and a proper second-order denominator. (Excludes higher-order or non-linear dynamics.)

Limit tests: As $s \to 0$, $Y/R \to K$ (steady gain). As $s \to \infty$, high-frequency gain → 0.

Use vs. sibling: Use this canonical form instead of plugging equations into $F = ma$ or RLC equations directly. Once you identify ζ, ω_n, apply the standard response formulas.

Common traps: Mixing up the $2\zeta\omega_n$ term (it must be exactly $2\zeta\omega_n$, not $\zeta\omega_n$). Forgetting the square on ω_n in the numerator (should be ω_n^2).

Equation Passport: Damped Natural Frequency

Name & Purpose: *Damped natural frequency* ω_d – frequency of oscillation for underdamped response. It tells you how fast the system oscillates.
Equation:

$$\omega_d = \omega_n\sqrt{1-\zeta^2}.$$

Variables & Units:

- ω_n: natural frequency (rad/s).
- ζ: damping ratio (unitless).
- ω_d: damped frequency (rad/s).

Assumptions: Only valid if $\zeta < 1$ (underdamped). If $\zeta \geq 1$, no real oscillation occurs.

Limit tests: As $\zeta \to 0$, $\omega_d \to \omega_n$ (pure sinusoid). As $\zeta \to 1$, $\omega_d \to 0$ (critical damping).

Common misreads: Don't confuse ω_d with ω_n. Ensure you use $\sqrt{(1-\zeta^2)}$, which requires $\zeta < 1$ (no negative under-root).

Equation Passport: Percent Overshoot (%OS)

Name & Purpose: *Percent Overshoot* – computes how much the first peak of an underdamped step response exceeds final value.

Equation:

$$\%OS = 100\exp\left(-\frac{\zeta\pi}{\sqrt{1-\zeta^2}}\right).$$

Variables & Units:

- ζ: damping ratio (unitless).
- *Output:* %OS (percent).

Assumptions: Valid for $0 < \zeta < 1$. Assumes a unit step input and starting from rest.

Included/Excluded: For $\zeta \geq 1$, define %OS = 0 (no oscillation). Formula inherently assumes exponential decay envelope.

Limit tests: If $\zeta \to 0$, exponent → 0, so %OS →100% (full swing). If $\zeta \to 1^-$, exponent→∞, %OS →0%.

Use vs. sibling: Use this formula instead of simulating the time response. (There is no analogous formula for overdamped systems, since %OS=0 then.)

Common traps: Ensure the argument of exp is dimensionless (use π, not 180°). Use the natural exponential; do *not* use log base-10. After computing the exponential (a fraction), multiply by 100 to get a percentage.

Equation Passport: Settling Time (2% criterion)

Name & Purpose: *Settling Time (T_s)* – time for output to stay within ±2% of final value. Useful for speed-of-response specs.

Equation:

$$T_s \approx \frac{4}{\zeta\,\omega_n}.$$

Variables & Units:

- ζ: damping ratio (unitless).
- ω_n: natural frequency (rad/s).
- *Result:* T_s in seconds.

Assumptions: Based on the 2% criterion for underdamped systems ($0 < \zeta < 1$). For a 5% criterion, a common approximation is $T_s \approx 3/(\zeta\,\omega_n)$.

Included/Excluded: Only applies to underdamped or even critically damped with ζ > 0. Overdamped case settles faster (this formula gives a conservative, slower estimate).
Limit tests: As $\zeta \to 0$, $T_s \to \infty$ (never settles). As ζ or ω_n increases, T_s decreases.

Common traps: Remember this is approximate (2% standard). Don't use this if ζ=0 (pure sine) – it would give infinite time. Always ensure ω_n in rad/s.

Definition Passport: Damping Ratio (ζ)

Definition: A dimensionless measure of damping: $\zeta = c/\left(2\sqrt{km}\right)$ for a spring–mass–damper, or $\zeta = R/(2)\sqrt{C/L}$ for a series RLC circuit. It quantifies friction relative to inertia.

Where it matters: In any control or vibration problem, ζ tells you if the system will oscillate and how much. The FE exam uses ζ in questions about dynamic response (e.g., "Given ζ, find %OS").

Pitfall: Students may confuse ζ with percentage (it's a plain ratio, not expressed as %). Also, ζ automatically uses the *undamped* ω_n in its definition.

Micro-check: True/False: If ζ=0.5, the system will overshoot its final value. (Answer: True – underdamped systems overshoot.)

K13.T03.S03 – Damping in Second-Order Systems

- The **damping ratio** ζ describes energy loss (like friction) in a second-order system. It determines the shape of the time response. If $\zeta < 1$, the system is **underdamped** (it oscillates with a decaying amplitude); if $\zeta = 1$, it is **critically damped** (no oscillation and the quickest return without overshoot); and if $\zeta > 1$, it is **overdamped** (no oscillation, but a slower response). These definitions are given in the exam handbook.

- Physically, underdamped means the system "rings" before settling (like a plucked guitar string), critically damped is the borderline case (just avoids overshoot), and overdamped means it returns sluggishly (too much "friction" or damping).

- Time-domain behavior differs: underdamped yields an exponential-sinusoid response with overshoot; critically damped reaches the final value fastest without overshoot; overdamped is sluggish and monotonic.

- Key performance metrics: *percent overshoot* (), *settling time* (T_s), and *logarithmic decrement* (δ) are used to quantify the response. For example, the handbook gives formulas for the logarithmic decrement and for $T_s \approx 4/(\zeta\omega_n)$.

Exam Handbook Search Cues (Not affiliated with or endorsed by NCEES): *damping ratio* (ζ); *underdamped/overdamped/critically damped*; *percent overshoot*, *logarithmic decrement*, *2% settling time*.

Footnotes:

- *Note:* The damping ratio ζ is dimensionless (no units). It is usually defined as $\zeta = c/\left(2\sqrt{km}\right)$ in a mass–spring–damper system, where c is damping coefficient.
- *Note:* The natural frequency ω_n is in rad/s. The damped natural frequency is $\omega_d = \omega_n\sqrt{1-\zeta^2}$ (for $\zeta < 1$).
- *Scope:* This analysis assumes a *single-degree-of-freedom*, linear, time-invariant system. Nonlinear or multi-mode dynamics are beyond FE scope.
- *Convention:* We assume a positive step input. Percent overshoot is reported as a positive percentage (e.g. 20% overshoot). Watch for whether questions use decimals (e.g. 0.20) or percent.

Variations & Typical Values:

- *Alternate forms:* The second-order transfer function can also be written using the damping ratio as $G(s) = K\omega_n^2/(s^2 + 2\zeta\omega_n s + \omega_n^2)$. In chemical process notation, sometimes $\tau = 1/\omega_n$ is used with $s^2 + 2\zeta/\tau s + 1/\tau^2$.

- *Percent overshoot:* For underdamped systems, . (Solve for ζ by taking ln if needed.)

- *Settling time:* By definition, the 2% settling time is $T_s \approx 4/(\zeta\omega_n)$. (Or 5% settling uses $3/(\zeta\omega_n)$.)

- *Special cases:* If $\zeta = 0$, the system is undamped and oscillates sinusoidally forever (purely oscillatory). If $\zeta \to \infty$, the mass is heavily damped (almost immovable). Critical damping ($\zeta = 1$) is the *boundary* between oscillatory and non-oscillatory.

- *Typical damping:* Mechanical systems often have ζ between 0 and 1 (light to moderate damping). $\zeta \approx 0.7$ gives a relatively fast response (~5% overshoot). High ζ (≥2) are rare except in systems with strong friction or control (heavy overdamping).

Special Notes (Calculator Tips):

- To compute $\exp\left(-\zeta\pi/\sqrt{1-\zeta^2}\right)$ for %OS, use the calculator's exp and sqrt functions carefully with parentheses. TI and Casio models require entering arguments as, e.g., exp((-zeta*pi)/sqrt(1-zeta^2)).

- For the logarithmic decrement $\delta = (1/m)\ln(x_k/x_{k+m})$, use natural log (ln) key; check that amplitudes x_k are positive values from successive peaks.

- Ensure the calculator is in radian mode when using trigonometric or exponential functions with radian inputs (e.g. ω_n in rad/s times time in seconds).

Explanation & Analysis:
The key equation is the **second-order system differential equation** (or its transfer function). In practical terms, it tells you how output $y(t)$ responds to an input $x(t)$ given the system's parameters: damping ratio ζ, natural frequency ω_n, and gain K. For a unit step input, the output depends on these parameters:

- If $\zeta < 1$ (underdamped), the output oscillates with decaying amplitude: $y(t)$ overshoots the final value, then crosses back, etc., eventually settling. The first peak occurs at $t_p = \pi/\left(\omega_n\sqrt{1-\zeta^2}\right)$ and the *percent overshoot* is $e^{-\zeta\pi/\sqrt{1-\zeta^2}} \times 100\%$. The *damped frequency* of oscillation is $\omega_d = \omega_n\sqrt{1-\zeta^2}$.
- If $\zeta = 1$ (critically damped), the system returns to steady state rapidly without oscillations. Mathematically, the solution has the form $y(t) = (A + Bt)e^{-\omega_n t}$, which reaches the final value without overshoot. This is the fastest no-overshoot response.
- If $\zeta > 1$ (overdamped), the response is a sum of two decaying exponentials with no oscillation. It takes longer to reach the final value than the critically damped case. The larger ζ is, the slower the approach.

Term-by-term: The symbol ζ (zeta) is central: it encodes damping. Its unit is none. ω_n is the *undamped natural frequency*, in rad/s, determined by the system's stiffness and inertia (like $\sqrt{k/m}$ for a spring–mass). The gain K is the steady-state ratio of output change to input change (often normalized to 1 for pure time-response shapes). An incorrect unit for ω_n (like using Hz instead of rad/s) or sign error in formulas for overshoot (e.g. dropping the negative in $-\zeta\pi$) will give wrong answers.

Common pitfalls: Students sometimes mix up **critical** vs **over** damped: remember *critical* (ζ=1) is the fastest return without overshoot, whereas *over* (ζ>1) is slower. Another trap is forgetting that percent overshoot goes to zero when $\zeta \geq 1$, so if you compute an overshoot formula and get a complex number (for $\zeta > 1$), treat it as 0%. Also note: in formula $\omega_d = \omega_n\sqrt{1-\zeta^2}$, if ζ is given as a percentage (like 20% damping), convert to decimal 0.20 first. And double-check that your calculator is in the correct mode for trigonometric or exponential functions.

Takeaways for FE: To solve a question on dynamic response, first *identify the damping ratio*. Compare it to 1 to classify the response (using the textbook definitions from the exam handbook). If underdamped, use the % overshoot and settling-time formulas (listed in the exam handbook). If critically or overdamped, expect *no overshoot*. Always write down units and check that exponents and radicals are entered correctly into your calculator. With these steps you can reliably analyze or synthesize second-order system behavior on the FE Mechanical Exam.

Topic 04 - Measurement Uncertainty

In practice every measurement or calculation has a "wiggle room" – a range of possible true values. **Measurement uncertainty** is the engineering concept that quantifies this "wiggle room." It matters because on exam day you must **report answers with no more precision than your data allow**. In other words, you can't claim more certainty than what you actually know. For example, if a question gives two lengths (say 12.3 m and 4.567 m) and asks for their sum or product, you must round the final answer according to the least precise input. Typical FE problems will expect you to use *significant figures* to carry through precision correctly and then round the final result. Mastering these rules helps ensure your answer reflects realistic precision – **a key part of "measurement uncertainty."**

K13.T04.S01 - Significant Figures in Calculations and Reporting

Significant Figures – digits that express the precision of a numeric value.

- *Where it matters:* In any FE Mechanical problem involving numbers, you must align the final answer's precision with the least precise input. Use significant-figure rules whenever you perform arithmetic so your reported result doesn't overstate its accuracy.
- *Common error:* Confusing decimal places with significant digits (the two rules differ for addition vs. multiplication) or rounding at the wrong time (e.g. rounding intermediate steps too early).
- *Quick check:* True or False – "0.0020 (two thousandths) has **two** significant figures." *(Answer: True, because the trailing 0 after 2 in a decimal counts.)*

Principle: Significant figures indicate how many digits in a number are meaningful. Use these general ideas (see the exam handbook for official wording):
- Nonzero digits are always significant. Zeros can be significant or not:
- Zeroes *between* nonzero digits count.
- Leading zeros (placeholders before the first nonzero) do **not** count.
- Trailing zeros *after a decimal* do count (e.g. 2.50 has three sig figs).

- **Addition/Subtraction rule:** Align the decimal points. The result should be rounded so that its *decimal places* match the least number of decimal places in any input.

- **Multiplication/Division rule:** For products/quotients, report the answer using the significant-figure count of the least precise factor.

- **Final answers:** It's customary to keep about 3–4 significant figures in the result (as noted in the handbook), reflecting realistic precision.

Exam Handbook Search Cues: *significant figures*, *accuracy*, *precision*.

- *Units:* Remember to keep a space between number and unit (e.g. 5.20 m) and **do not count the unit** as a significant digit. Only the numeric portion matters for sig figs.
- *Guard digits:* It's wise to carry at least one extra digit through intermediate calculations to avoid rounding errors, then round off only the **final** result.
- *Notation:* Use scientific notation or a decimal point when needed to avoid ambiguity. For example, writing 5.00×10^3 (instead of 5000) clearly shows three sig figs. If an answer is exactly an integer power of ten, append a decimal (e.g. 5000. or use exponent form).
- *Exact values:* Defined constants or conversion factors (like 60 s = 1 min exactly) have "infinite" sig figs. They do **not** limit the precision of your result. Only measured or given values with finite digits do.

Related forms and notes:

- **Scientific notation:** Expressing a number as $a \times 10^n$ makes sig figs explicit. For example, 4.56×10^3 has three sig figs.
- **Exact counts:** Counting items (e.g. "3 students") is exact, not limiting sig figs.
- **Typical magnitudes:** FE problems usually give data to 2–4 sig figs. Expect answers around that precision. Very few problems need more than 5 significant figures; overly precise answers might indicate incorrect rounding.

Calculator tip: You can set your calculator to display a fixed number of decimals (Fix mode) or use scientific notation mode. For instance, on many Casio models press SHIFT → MODE → FIX and choose the number of decimals (or SCI for scientific). Always check that the calculator shows enough digits (even if it rounds on screen) so you can apply sig-fig rules manually on the final result.

Explanation & Analysis: Whenever you finish a calculation, ask "What is the least precise value that went into this?" The answer's sig figs come from that. For example, multiply 3.42 m (3 sig figs) by 2.1 m (2 sig figs): the raw product is 7.182 m², but with 2 sig figs it's reported as **7.2 m²**. The digit-by-digit analysis: "3.42" means the smallest mark measured was at 0.01 m, whereas "2.1" was only to 0.1 m – so the result is only certain to 0.1 m², hence 7.2.

For addition, say 3.456 m (3 decimals) + 1.7 m (1 decimal) = 5.156 m raw. Since 1.7 m is only precise to 0.1 m, round 5.156 to 5.2 m (1 decimal). Another trap: consider $1.230 + 0.0060 = 1.2360$. The first term has 3 decimals, the second has 4, so round to 3 decimals ⇒ **1.236 m**. (Here all trailing zeros shown count, because both had decimals.)

- **Why it's used:** This ensures your answer's precision does not exceed the inputs'. FE questions often expect the final numeric answer to look "right" in sig figs. Over-precise answers (e.g. giving 12.348 when you should give 12.35 or 12.3) can lose points or simply reflect a misunderstanding.
- **Step-by-step:** For each operation, identify how many sig figs or decimal places each operand has, then apply the appropriate rule above. Treat each symbol as a number with a given precision (no units involved in counting). After computing an exact value on your calculator, round it once *at the end*. Common pitfalls include counting the zeroes incorrectly and dropping precision early.

By strictly following the sig-fig rules, you "bake in" the measurement uncertainty into your answer formatting. Remember:

the goal is not just to get the number, but to **state it with the right precision**.

K13.T04.S02 – Measurement Uncertainty and Error Propagation

Principle:

- *Definition:* Measurement uncertainty is a quantitative estimate of the range within which the true value of a measured quantity is believed to lie. In other words, every instrument reading x carries an associated uncertainty σ_x (or ± tolerance) around it.

- If a result R depends on several measured inputs (e.g. $R = f(x_1, x_2, \dots, x_n)$), the combined uncertainty σ_R can be estimated by the **Kline–McClintock propagation** rule. Essentially, small independent uncertainties add in quadrature based on partial derivatives.

- By default, uncertainties are treated like standard deviations. When reporting a final result, it's typical to give an **expanded uncertainty** (often using a coverage factor $k = 2$ for ~95% confidence).

- Always carry through units: σ_R has the same units as R. When propagating uncertainties, use consistent units for each term.

Equation Passport: Kline–McClintock Uncertainty Propagation

- **Purpose:** Computes combined standard uncertainty in a quantity R that depends on independent variables x_i.

- **Equation:**

$$R = f(x_1, x_2, \dots, x_n), \qquad \sigma_R = \sqrt{\sum_{i=1}^{n} \left(\frac{\partial f}{\partial x_i}\right)^2 \sigma_{x_i}^2}.$$

- **Variables:** - R – result or computed quantity (units depend on context).
- x_i – independent measured input (each with units of R if additive, or appropriate units otherwise).
- σ_{x_i} – standard uncertainty of x_i, in same units as x_i.

- **Assumptions:** Valid for independent measurements and small (linear) uncertainties. Assumes errors are uncorrelated and random (no significant covariance). First-order Taylor approximation is used (linearization).

- **Limit tests:** If every $\sigma_{x_i} = 0$ (no error), then $\sigma_R = 0$. If one σ_{x_j} dominates (≫ others), $\sigma_R \approx |\partial f / \partial x_j| \, \sigma_{x_j}$. If inputs are unrelated to R (∂f/∂x = 0), that term drops out.

- **Use vs. sibling formulas:** Use this propagation formula instead of a simple arithmetic sum of errors when uncertainties are independent. (For worst-case bounds, you would sum magnitudes, but the exam usually expects root-sum-square for standard uncertainty.)

- **Common exam traps:** Forgetting to square the partial terms, mixing relative and absolute errors, or omitting the derivative factor. Also watch unit consistency: check that σ_{x_i} has correct units before summing in quadrature.

Footnotes:

- *Note:* Uncertainty σ_R carries the same units as the quantity R. Always square the uncertainties (even if values are given as ±Δ) before summing.
- *Note:* The formula assumes *independent* (uncorrelated) inputs. If two measurements are correlated, covariance terms appear (beyond FE scope).
- *Note:* Expanded uncertainty with $k = 2$ means multiply the calculated σ_R by 2 to get an approximate 95% confidence interval.

Variations, Special Cases:

- **Sum/Difference:** If $R = x_1 + x_2 + \cdots + x_n$ (or difference),

$$\sigma_R = \sqrt{\sigma_{x_1}^2 + \sigma_{x_2}^2 + \cdots + \sigma_{x_n}^2}$$

- **Product/Quotient:** If $R = x_1 x_2$ or $R = \frac{x_1}{x_2}$, propagate relative uncertainty:

$$\frac{\sigma_R}{|R|} = \sqrt{\left(\frac{\sigma_{x_1}}{x_1}\right)^2 + \left(\frac{\sigma_{x_2}}{x_2}\right)^2}$$

- **Single variable:** If $R = ax$ (with constant a), then $\sigma_R = |a| \, \sigma_x$.

- **Typical values:** Instruments often specify accuracy in % or as ± a given value. For a well-behaved instrument, $k = 2$ (≈95%) is commonly used, so final uncertainty ≈ $2\sigma_R$.

Explanation & Analysis:

To *use* this formula, you first identify the function $R = f(x_1, \dots, x_n)$. Then, for each input x_i, do the following:

1. **Differentiate:** Compute the partial derivative $\frac{\partial f}{\partial x_i}$. This tells you how sensitive R is to changes in x_i.

2. **Multiply by uncertainty:** Multiply that derivative by the standard uncertainty σ_{x_i} of that input. This gives the contribution of x_i to the output uncertainty.

3. **Combine in quadrature:** Square each contribution, sum them all, then take the square root to find σ_R.

For example, if $R = x + y$, then $\partial R / \partial x = 1$ and $\partial R / \partial y = 1$, so $\sigma_R = \sqrt{\sigma_x^2 + \sigma_y^2}$. If $R = xy$, then $\partial R / \partial x = y$ and $\partial R / \partial y = x$, so $\sigma_R = \sqrt{(y\,\sigma_x)^2 + (x\,\sigma_y)^2}$.

Check units and orders of magnitude: each term $(\frac{\partial f}{\partial x_i} \sigma_{x_i})^2$ has units of R^2. The result σ_R should match the units of R. A common mistake is to omit the derivative factor or to forget squaring before summing.

K13.T04.S03 – Accuracy vs. Precision (ISO Definitions)

Principle:

- **Accuracy:** How close a measurement (or average of measurements) is to the true or reference value. High accuracy means little systematic error.

- **Precision:** How repeatable measurements are (clustering together) under the same conditions. High precision means little random scatter.

- Accuracy and precision are independent. For example, measurements can be precise but not accurate (consistently off-center), or accurate but not precise (on average correct but widely scattered).

- In exam problems, **accuracy** often appears as % error or instrument accuracy (systematic offset), while **precision** may appear as standard deviation or repeatability.

Definition Passport: Measurement Accuracy

- **Definition:** Measurement accuracy describes **how nearly an instrument's reading matches a chosen reference or 'true' value for the quantity being measured**.

- **Where it matters:** Accuracy shows up when checking whether a result is biased. In FE problems, instrument accuracy might limit the final answer (e.g., a pressure gauge accurate to ±1%).

- **Pitfall/confusion:** Students often mix accuracy and precision. **Accuracy** deals with error relative to true value, while **precision** deals with variability. Using one term for the other is a common source of mistakes.

- **Micro-check:** *True or False:* "If a set of measurements has a large spread but on average equals the true value, it is accurate." (Answer: False – it's precise in average, but not precise in repetition.)

Definition Passport: Measurement Precision

- **Definition:** *Measurement precision* is the closeness of agreement between repeated measurements under unchanged conditions (often given as standard deviation or repeatability).

- **Where it matters:** Precision matters when combining data points. In instrumentation, precision determines how much random error is present. Calculating standard deviation or using multiple readings to reduce uncertainty relies on precision.

- **Pitfall/confusion:** Remember that **precision** doesn't guarantee **accuracy**. Highly precise instruments can consistently read wrong if improperly calibrated.

- **Micro-check:** *True or False:* "Three readings of a length all within 0.1 mm of each other are precise." (Answer: True – they are repeatable, regardless of accuracy.)

Footnotes:

- *Note:* Accuracy is often expressed as a percentage of full-scale or as an absolute error; precision is often given as σ or ± range from repeated tests.
- *Note:* ISO definitions (from JCGM 200:2012) are the official standard; some textbooks may use slightly different wording but the concept is the same.
- *Note:* In some contexts, accuracy is called *trueness* (statistical term) and precision is equivalent to *repeatability*.

Variations, Related Forms:

- **Systematic vs Random Error:** Accuracy is tied to *systematic errors* (biases, instrument calibration). Precision is tied to *random errors* (scatter, noise). Often, accuracy can be improved by calibration, and precision by averaging many trials.

- **Combined effects:** An experiment can be *highly precise but poorly accurate* (tight cluster far from target) or *highly accurate but imprecise* (hits near center on average but widely spread).

- **Typical magnitudes:** Bench instruments might have accuracy ~0.5–5% of reading, whereas precision (σ) might be much smaller after filtering noise. FE problems often use a given ± tolerance directly.

Explanation & Analysis:

Think of a dartboard: precision means darts cluster together; accuracy means they hit near the bullseye. In solving FE problems, ask yourself: *Am I estimating how close I am to the true value (accuracy) or how repeatable my measurement is (precision)?*

- **Accuracy usage:** When an instrument spec says "accuracy = ±2%," treat that as a systematic error limit. You might subtract true–measured or calculate percent error to see if you're within tolerance.
- **Precision usage:** When given several trials or a stated standard deviation, you use precision to estimate the spread (e.g. you might combine multiple readings to reduce uncertainty by $1/\sqrt{N}$).

A common trap is using significant figures (precision of numbers) as a stand-in for measurement precision; they are related but not the same concept. Always align accuracy with closeness to true value and precision with repeatability.

K13.T04.S04 – Significant Figures and Rounding

Principle:

- Significant figures (sig figs) indicate the meaningful digits in a number, reflecting its precision. When calculating and reporting results on the FE exam, follow standard rules so as not to imply false precision.

- In **addition/subtraction**, align decimal points: the result is rounded so that the least certain decimal place from any term is the last kept (Rule 4).

- In **multiplication/division**, the result is rounded to the same number of sig figs as the factor with the fewest sig figs (Rule 5).

- As a convention, final answers on the FE exam are typically given with **3 or 4 significant digits** (unless context or unit systems require otherwise). Avoid more digits than justified by the least precise input.

Definition Passport: Significant Figures

- **Definition:** *Significant figures* are all the digits in a number that carry meaningful information about its precision (excluding leading zeros).

- **Where it matters:** Sig figs ensure you don't overstate accuracy when combining measured values. On the FE, use sig-fig rules to round intermediate and final results appropriately.

- **Pitfall/confusion:** Mixing up "number of sig figs" with "decimal places." For example, 0.050 has two sig figs ("5" and "0" after it), even though only one non-zero digit is shown.

- **Micro-check:** *True or False:* "If you multiply 2.345 (4 sig figs) by 3.1 (2 sig figs), the answer should have 2 sig figs." (Answer: True.)

Footnotes:

- *Note:* In the exam handbook, sig-fig rules are listed under Units & Conversions. When in doubt, break a calculation into steps and round only the final result to the correct sig figs.
- *Note:* Exact values (like 1 m = 1000 mm) do not limit sig figs. Only values from measurement or inexact constants dictate precision.
- *Note:* When dealing with logarithms or exponents, different rounding rules apply (e.g., decimal places for logs), but these are usually handled by the calculator output.

Variations, Special Cases:

- **Trailing Zeros:** A zero after a decimal point (e.g. 2.0) is significant; a zero before a decimal (e.g. 200) may or may not be, depending on context (but on FE assume trailing zeros without a decimal are significant if explicitly given).
- **Scientific Notation:** Expressing results in scientific notation makes sig-figs clear. For instance, 2.00×10^2 has three sig figs.
- **Typical practices:** Engineers often keep 3–4 sig figs in the final answer. (Intermediate steps may carry extra digits to reduce round-off error, but do not count them as final precision.)

Explanation & Analysis:

When performing a calculation:
1. **Check the least precise input:** Identify which value has the fewest sig figs (for ×/÷) or the fewest decimal places (for +/−).
2. **Round at the end:** Calculate using full precision, then round the final answer according to the rules, not each intermediate step.

For example, $6.02 \times 1.0 = 6.02$ but rounded to 2 sig figs (since 1.0 has 2 sig figs) gives **6.0**. If you add $12.345 + 0.4 + 3.1$, align decimals: the least precise term is 0.4 (one decimal place), so sum = 15.845 → round to 15.8 (one decimal place).

Be careful not to confuse the rules: *Addition/subtraction care about decimal places*, *multiplication/division care about total sig figs*. Always double-check by asking if adding an extra digit really reflects new information.

K13.T04.S05 - Measurement Errors: Systematic vs Random

- **Measurement error definition:** Measurement error is the difference between a measured value and the true (reference) value. It arises from imperfections and noise in the measurement process.
- **Systematic error (bias):** A consistent, repeatable offset that shifts all measurements in the same direction. Examples include mis-calibration, zero-offset in a sensor, or drift over time. Systematic errors *reduce accuracy* (closeness to true value).
- **Random error (noise):** Unpredictable fluctuations around the true value, caused by random disturbances (e.g. electrical noise, turbulent flow variability). Random errors affect *precision* (repeatability) but average out over many trials.

  Error model: You can represent a single measurement as
  $$x = x_{\text{ref}} + d_{\text{systematic}} + d_{\text{random}},$$
  where *x* is the measured value, *x_ref* is the true value, *d_systematic* is the bias, and *d_random* is the random noise. This shows that systematic and random errors add to the true signal in different ways.

Footnotes:

Error and uncertainty share the same units as the measured quantity. By convention, systematic error is often treated as a signed offset (e.g. +Δ or –Δ), while random error is characterized by a standard deviation or range (never assumed to have a fixed sign). We assume here that systematic and random components are uncorrelated (independent).

Variations & Typical Values:

- If multiple systematic biases exist (e.g. two calibration offsets), their effects simply add algebraically. For example, two +1°C biases yield a +2°C overall shift.

- Independent random errors combine by root-sum-square: if two independent random errors have σ1 and σ2, the net random error is $\sqrt{\sigma_1^2 + \sigma_2^2}$.

- Repeated measurements reduce random error: averaging N repeats reduces the standard error to σ/√N, while the systematic bias remains unchanged.

- Typical instrument specs might quote ±(0.5% of reading + 1 digit) – the percent term is an error proportional to value (systematic if uncorrected), and the fixed-digit term adds random noise.

- Accuracy (largely systematic effects) and precision (largely random scatter) are often tested together: think 'distance from the reference value' (accuracy) versus 'how tightly repeated readings cluster' (precision).

Common Exam Traps: Confusing accuracy with precision. Remember: a perfectly precise but biased instrument (small random scatter, large offset) is inaccurate, while a high-precision and unbiased instrument is accurate. Also, failing to remove zero-offset (systematic bias) before computing averages. Always check if a problem explicitly mentions calibrating or offset errors, as these must be subtracted.

Explanation: In FE problems, you will use this concept when analyzing measurement data. For instance, if a pressure transducer consistently reads +2 psi above the true pressure (bias), that's a systematic error to correct. Meanwhile, if repeated pressure readings vary by ±0.3 psi, that is random error (precision). Identifying the error type is essential: systematic errors must be calibrated out or added to the uncertainty range, whereas random errors are handled statistically (e.g. via standard deviation).

Analysis: In the model $x = x_{\text{ref}} + d_{\text{syst}} + d_{\text{rand}}$:

- *x* and *x_ref* both have the units of the quantity measured (e.g. volts, psi).

- *d_systematic* is the bias (e.g. an offset voltage or calibration error). It has the same units and sign (+ or –). For example, if a voltmeter reads 0.05 V high, then $d_{\text{syst}} = +0.05$ V.

- *d_random* is random noise (often modeled as zero-mean). It is typically described by a standard deviation σ_d (units same as x). Over many readings, the mean of d_{rand} is zero, but individual measurements scatter.

- Since systematic error adds a constant shift, averaging does **not** reduce it. By contrast, averaging N independent random errors reduces the net noise level by $1/\sqrt{N}$.

- Pitfall: Do **not** mistake a repeated high bias for a random spike. If one reading is way off, that's likely a one-time random outlier; but if *all* readings are off, that's systematic.

K13.T04.S06 - Propagation of Uncertainty (Kline–McClintock)

- **Purpose:** When a calculated result depends on multiple measured values, each with its own uncertainty, we use the Kline–McClintock formula to find the overall uncertainty in the result. In practice, if $y = f(x_1, x_2, \dots, x_n)$ and each x_i has a known standard deviation (uncertainty) σ_{x_i}, then the output uncertainty σ_y is given by a root-sum-of-squares of partial derivatives (see **Equation Passport** below).
- **Key idea:** Treat the errors in x_i as small deviations and linearize f around the nominal values. Each x_i contributes $\frac{\partial f}{\partial x_i}\sigma_{x_i}$ to the uncertainty in y. Assuming the x_i are independent, we combine these contributions in quadrature (sum of squares).
- **When to use:** Any time the exam gives a function of multiple measured quantities and asks for the uncertainty or error in the result. For example, computing the volume of a cylinder from measured diameter $d \pm \sigma_d$ and height $h \pm \sigma_h$.
- **Assumption:** The errors in x_i are uncorrelated (independent). The formula is an approximation, valid for small uncertainties (linear approximation).

Equation Passport – Kline–McClintock (Error Propagation)

Name/Purpose: Kline–McClintock (Propagation of Uncertainty) – computes the combined standard uncertainty of a function of independent variables.

Professional form (SI units):

$$\sigma_y = \sqrt{\sum_{i=1}^{n}\left(\frac{\partial f}{\partial x_i}\right)^2 \sigma_{x_i}^2},$$

where $y = f(x_1, \dots, x_n)$. Equivalently, sum the squares of each term's contribution and take the square root.

Variables/Units:

- σ_y = resulting standard uncertainty (same units as y).
- f = function relating inputs to output.
- x_i = input measured values (each with its own units).
- $\partial f/\,\partial x_i$ = sensitivity of y to x_i (units of y/x_i).
- σ_{x_i} = standard uncertainty in x_i (same units as x_i).

Assumptions/Scope: Valid for *uncorrelated* input uncertainties and when the function can be linearized (errors small). Assumes statistical (random) errors; does not apply to systematic biases. Out of scope: correlated variables (no cross terms), large nonlinear effects.

Limit tests (sanity checks): If all $\sigma_{x_i} \to 0$, then $\sigma_y \to 0$ (perfect inputs give perfect result). If any $\sigma_{x_i} \to \infty$, then $\sigma_y \to \infty$. These ensure you haven't inverted units or signs.

Use vs sibling equations: Use K-M for **random** independent errors. Do *not* use it if errors are fully correlated (those need a different treatment) or if you are asked for a worst-case absolute error (which would be a simple sum instead of RSS).

Common exam traps: Forgetting to square the derivative term, or forgetting the partial derivative entirely (e.g. treating $y = x_1^2$ but using $\sigma_y = 2\sigma_{x_1}$ instead of $2x_1\sigma_{x_1}$). Mixing up percentage vs absolute uncertainties. Assuming K-M handles systematic bias (it does not – biases must be treated separately). Using fewer significant figures in intermediate steps (propagated uncertainties can be sensitive to rounding).

Footnotes: The exam handbook notes that expanded uncertainties (≈95% confidence) use a coverage factor $k = 2$ (roughly 2σ). K-M calculates the *standard* uncertainty (1σ). Also, units: since $\partial f/\,\partial x_i$ has units (units of y/units of x_i), the term $(\partial f/\,\partial x_i)\sigma_{x_i}$ has units of y, so σ_y is in y units.

Variations & Examples:

- *Sum/Difference:* If $y = x_1 + x_2$ (or $x_1 - x_2$), then $\frac{\partial f}{\partial x_1} = \frac{\partial f}{\partial x_2} = 1$, so $\sigma_y = \sqrt{\sigma_{x_1}^2 + \sigma_{x_2}^2}$. (RSS of errors.)

- *Product/Quotient:* If $y = x_1 x_2$, one can use relative form: $\frac{\sigma_y}{y} = \sqrt{\left(\frac{\sigma_{x_1}}{x_1}\right)^2 + \left(\frac{\sigma_{x_2}}{x_2}\right)^2}$. Likewise for $y = x_1/x_2$.

- *No error term:* If some x_i is exactly known or constant, its $\sigma_{x_i} = 0$ so it contributes nothing.

- *Many terms:* If f has many terms, include each derivative term. E.g. $y = ax + b$ has $\sigma_y = |a|\,\sigma_x$ (since $\partial f/\,\partial x = a$).

- *Worst-case bound:* In some problems they may compare root-sum-square (RSS) vs linear sum (pessimistic bound). For conservative estimate, one could sum absolute contributions $\sigma_y \le \sum|\partial f/\,\partial x_i|\sigma_{x_i}$, but RSS is standard for FE problems.

Explanation: The propagation-of-error formula is used whenever a quantity depends on multiple measurements. On the FE exam, you might see it when calculating derived quantities (e.g. volume, flow, stress) from measured values. For instance, finding the combined uncertainty of $V = \pi(D/2)^2 L$ given uncertainty in D and L. You would apply Kline–McClintock to find σ_V.

Analysis: Each term $\frac{\partial f}{\partial x_i}\sigma_{x_i}$ represents how an uncertainty in x_i spreads into y. For example, if $y = x_1^2$, then $\partial f/\,\partial x_1 = 2x_1$, so a small error σ_{x_1} causes $\sigma_y = |2x_1|\,\sigma_{x_1}$. In $\sigma_y = \sqrt{\sum(\partial f/\,\partial x_i)^2\,\sigma_{x_i}^2}$:

- The square root means we are adding independent contributions in quadrature.

- Each σ_{x_i} should be in absolute units (not percent). If given percent, convert (e.g. 5% of 20 = 0.05×20 = 1.0 unit).

- Ensure derivatives are evaluated at the nominal values of x_i. For linear functions, the formula simplifies as shown above.

- After computing σ_y, you typically report the result as $y \pm \sigma_y$ (or as an interval).

- A common pitfall: forgetting to apply the factor $k = 2$ if the problem asks for 95% range. The formula gives 1σ; multiply by 2 for ~95% confidence.

K13.T04.S07 - Significant Figures and Rounding

Definition: Significant figures (sig figs) are the digits in a number that carry meaning in terms of precision. They include all nonzero digits, and any zeros between or after significant digits (if the position is known). Leading zeros are *not* significant. For example, 0.040 has two sig figs (4 and the trailing 0), while 0.0400 has three.

When it matters: On the FE exam, any time you present a numerical answer, it should not imply more precision than the given data. Results are usually expected with 3–4 significant figures (exam convention). Using the correct number of sig figs helps avoid answers that are too precise or too vague.

General rules: (i) For multiplication/division, the answer should have as many sig figs as the least precise factor. (ii) For addition/subtraction, align decimal places and match the least decimal precision among inputs. (iii) Non-zero digits and zeros between them always count; trailing zeros count if there is a decimal point.

Exam search cues: *significant figures*, *rounding*, *accuracy*, *precision*.

Footnotes:

There are no "units" for significant figures – they apply to the numeric value itself. However, ensure your numeric format matches the units (e.g. 1.20×10^3 m has three sig figs for 1200 with a decimal). If a problem statement explicitly states a number of sig figs or decimal places, follow that.

Variations & Examples:

- *Multiplication:* $2.30\text{ cm} \times 4.1\text{ cm} = 9.43\text{ cm}^2$. Here 2.30 has 3 sig figs, 4.1 has 2, so result should have 2 sig figs: answer = 9.4 cm².

- *Addition:* $1.234 + 5.6 = 6.8$. Align by decimal: 1.234 (3 decimals) + 5.600 (rounded to 5.6, 1 decimal) yields 6.8 (1 decimal place).

- *Rounding:* Always round the final answer. Keep at least one guard digit in intermediate steps if possible. If a result is exactly on a mid-point (e.g. ...5), round to nearest even (exam doesn't usually hinge on this detail).

- *Scientific notation:* Useful to avoid ambiguity. Example: 1200 (no decimal) has 2 sig figs, but 1.200×10^3 has 4 sig figs. Use "$\times10^n$" to clearly indicate significant trailing zeros.

- *Exact values:* Conversion factors or counted values are assumed exact (infinite sig figs). Do not count those in sig-fig calculations.

Common Exam Traps: Misinterpreting leading vs trailing zeros. For example, 0.0050 has two sig figs (5 and 0), not one. Another trap is neglecting to match decimal places on subtraction, or inadvertently dropping a digit early. Also watch unit prefixes: "1000 mL" usually has one sig fig unless written "1.000×10^3 mL."

Explanation: On the exam you will often be given input values with a certain precision. The answer should not suggest unwarranted accuracy. For instance, if a length is given as 12.3 cm (3 sig figs) and width as 4.56 cm (3 sig figs), an area might be 12.3×4.56 = 56.088 cm², but you would report **56.1 cm²** (3 sig figs).

Analysis: To apply sig fig rules, first identify all significant digits in the inputs:

- In 0.00230, the "230" are significant (3 sig figs). In 1500 (no decimal), only "15" are significant (2 sig figs). In 1500. (with a decimal), all four digits are significant (4 sig figs).

- When combining numbers: for **addition/subtraction**, align decimals and round off based on the least precise decimal place. E.g. 123.45 + 6.7 → align to tenths: 123.45 + 6.70 = 130.15, round to 130.1 (tenths place). For **multiplication/division**, count total sig figs in each factor, and give result with the minimum of those.

- Common mistake: Rounding too early. Keep extra digits during calculation and only round the final result. For example, computing 7.85×0.041 (3 sig figs each) should yield ~0.3219, then round to 0.322 (3 sig figs), not 0.32.

- *Micro-check:* Is the result more precise than the inputs? E.g. if inputs are ~1% precision, the result cannot legitimately be 0.1% precision.

Definition (Significant Figures): The significant figures of a number are all digits that convey reliable information about its value. This includes all nonzero digits and any zeros that are known to be precise (for example, a trailing zero in 2.50 or a zero between digits in 101.0). In other words, sig figs *measure the precision* of a number.

Exam Impact: You will use sig-fig rules whenever a question involves rounding or when a numeric answer must match the precision of given data. Practicing these rules helps ensure your answer is accepted (the exam's answer keys expect properly rounded results).

Pitfall: A common confusion is with zeros. Remember that 0.040 has two sig figs (the "4" and the final "0"), but 0.0400 has three, and 400 (no decimal) has one. Also watch units: writing 50.0 cm suggests 3 sig figs, whereas 50 cm (no decimal) suggests 1.

Quick Check (True/False):

> *True or False:* A measurement reported as 0.020 m has two significant digits.
> **Answer:** *True* (the digits "2" and the trailing "0" in 0.020 are significant; the leading zeros are not).

K13.T04.S08 – Measurement Uncertainty (Definition)

Concept: Uncertainty is not "error" but a range estimate. It tells you **how confident** you are in a measurement. Every instrument spec (for example, a digital voltmeter or ruler) comes with an accuracy/tolerance. The uncertainty is a **quantitative estimate** of how far the measured value might be from the true value.

Intuition: Think of uncertainty like error bars on a graph. If a length is 10.00 m ± 0.02 m, the true length is believed to lie somewhere between 9.98 m and 10.02 m.

Context: On the FE Mechanical exam, uncertainty appears in Instrumentation and Measurements questions or anytime you do an error analysis. You must report uncertainties to ensure solutions are meaningful (e.g. final answer ± uncertainty).

Terminology: The symbol for uncertainty is often "w" or "σ" (sigma). If $x \pm w$ is given, w is the *standard uncertainty* (1σ). An *expanded uncertainty* (with coverage factor $k = 2$) encloses ~95% confidence.

Definition Passport: *Measurement Uncertainty* – a concise concept block.

- **Definition:** Measurement uncertainty **quantifies the width of an interval of plausible values for the true quantity, based on the measurement and its assumptions**. For instance, *5.00 s ± 0.10 s* means the actual time is believed between 4.90 s and 5.10 s.

- **Where it matters:** Used whenever you combine measurements. For example, uncertainty in pressure and temperature may affect your answer in fluid mechanics problems. The *exam handbook keywords* include *"measurement uncertainty"*, *"tolerance"*, or *"error propagation"*.

- **Common pitfall:** Don't confuse uncertainty with bias or error. Uncertainty is **not** a signed error; it's always positive and describes a range. Also, it is **not** the difference from the true value (which is unknown). It's an estimate of possible variation.

- **Quick check (T/F):** *If a length is 50.0 cm ± 0.2 cm, then the true length could be 49.9 cm.* **True** (because 49.9 cm lies within 50.0±0.2).

Exam Handbook Search Cues (Not affiliated with or endorsed by NCEES): *"measurement uncertainty", "tolerance", "true value range"*. (Use these keywords in the exam handbook to find definitions and formulas.)

Notes: Uncertainty is **dimensionful** – it has the same units as the quantity measured (e.g. meters, seconds). Always pair the ± number with units. We usually assume **independent errors** unless told otherwise. In this chapter, we focus on uncorrelated uncertainties.

Variations/Related Concepts:

- **Absolute vs. Relative Uncertainty:** You may compute percent uncertainty by $\frac{w}{x} \times 100\%$. For example, 0.02 m uncertainty on 10.00 m is 0.2%.

- **Typical magnitudes:** Experimental devices often have uncertainties of a few percent or smaller. For high-precision lab instruments, uncertainty might be 0.1–1%.

- **Expanded Uncertainty (95% conf):** Often $k = 2$ is used (called 2σ), meaning roughly 95% confidence range. This doubles the standard uncertainty for reporting if needed.

Special notes (calculator): No special calculator tricks for uncertainty itself – just be ready to square and square-root. (On HP/TI calculators use x^2 and √ operations carefully with parentheses.)

Explanation & Analysis: Measurement uncertainty is used when you need to communicate how precise a result is. On the FE exam, a common task is to propagate instrument errors: given values like $L = 2.50 \pm 0.05$ m and $w = 1.20 \pm 0.02$ m, compute area $A = L \times w$ and its uncertainty. Here you **combine** the uncertainties in a formula (next subtopic). The formula for combined uncertainty comes from treating each input's variation and summing their contributions. Each symbol in $x \pm w$ means the measurement x and its uncertainty w (in same units). A frequent mistake is forgetting to express the final answer as "value ± uncertainty" with the correct number of significant figures.

K13.T04.S09 – Accuracy and Precision (Definitions)

- **Concept:** Accuracy and precision are different aspects of measurement quality. *Accuracy* describes closeness to the true value, while *precision* describes repeatability. A high-accuracy instrument gives values near the true value; a high-precision instrument gives nearly the same result when you repeat the measurement.
- **Intuition:** Imagine an archery target: accurate shots (clustered near bullseye) vs. precise shots (clustered tightly, even if off-center). An instrument can be precise (low scatter) but inaccurate (biased), or vice versa.
- **Context:** These terms show up in definitions and conceptual questions. The FE exam may ask which instruments to use or what contributes to uncertainty. Understanding accuracy vs. precision helps interpret given tolerances.
- **When it appears:** Exam handbook uses definitions (ISO standard) for these terms. Look up *"accuracy"* or *"precision"* in the Instrumentation section.

Definition Passport: *Measurement Accuracy*

- **Definition:** How far the reported reading is from the reference value (small difference = high accuracy).

- **Exam impact:** Affects systematic error. If a scale is off by +1%, all readings are shifted. The handbook keywords: *"accuracy (true value)"*.

- **Pitfall:** Don't confuse with precision. An instrument can be accurate on average but give scattered results (low precision).

Definition Passport: *Measurement Precision*

- **Definition:** Closeness of repeated measurements to each other. It reflects random error or scatter.

- **Exam impact:** Precision affects statistical uncertainty. For example, repeated timer readings vary due to human reaction time – that's a precision issue. Keywords: *"precision (reproducibility)"*.

- **Pitfall:** An instrument with poor precision yields large uncertainty even if it's unbiased.

Exam Handbook Search Cues (Not affiliated with or endorsed by NCEES): *"measurement accuracy", "measurement precision", "ISO definitions"*.

Notes: Accuracy often has no units (it is a relative or absolute difference), precision is statistical. In formulas, we use *uncertainty* to capture both effects.

Variations: - If you have replicate measurements $x_1, x_2, \ldots$, precision is related to the standard deviation of those values.
- *Bias vs. Precision:* Exams might mention a "zero-offset" error (accuracy issue) vs. "noise" (precision issue).

Special notes: No calculator specifics here. Just keep clear: accuracy ↓ uncertainty is low, precision ↑ reproducibility.

Explanation & Analysis: Remember: Accuracy = "true vs measured" (low bias); Precision = "measurement vs measurement" (low scatter). On the exam you might see a statement like "instrument A has better accuracy than B" – it means A's readings

are closer to the correct value. Precision shows up as uncertainty: an instrument that records many digits but jiggles a lot has high precision (many sig figs) but if they're off target, it's not accurate. A classic confusion: *"Which matters more?"* Both matter when quantifying uncertainty, but the formulas we use assume we only know uncertainty values, not which is systematic vs random.

K13.T04.S10 – Uncertainty Propagation (Kline–McClintock Equation)

Concept: When a result R is computed from several measured inputs $x_1, x_2, \dots, x_n$, each with its own uncertainty w_i, the combined uncertainty w_R is found by the *propagation of uncertainty* formula. For uncorrelated inputs, this is given by the Kline–McClintock equation.

Equation (formal):

$$\sigma_R = \sqrt{\sum_{i=1}^{n} \left(\frac{\partial f}{\partial x_i}\sigma_{x_i}\right)^2} \quad ,$$

where $R = f(x_1, x_2, \dots, x_n)$ and $\sigma_{x_i} = w_i$ is the standard uncertainty of x_i.

Intuition: Linearize f around the measured values. Each term $(\partial f / \partial x_i)\, \sigma_{x_i}$ represents how much uncertainty in x_i contributes to R. You square and sum these contributions (like "adding squares") because errors are treated statistically.

Context: This formula appears under keywords "error propagation" or "uncertainty propagation" in the exam handbook. Questions may give a function (like volume of a cylinder $V = \pi d^2 h/4$) and uncertainties in d and h, and ask for the uncertainty in V.

Application: Always use this exact form when combining independent uncertainties. Simpler shortcut rules (see variations) are just special cases of this formula.

Equation Passport: *Kline–McClintock (Uncertainty Propagation)* – for **combined uncertainty**

- **Purpose:** Computes the standard uncertainty of a computed result $R = f(x_1, \dots, x_n)$ given uncertainties in inputs.

- **Professional equation:**

$$\sigma_R = \sqrt{\sum_{i=1}^{n} \left(\frac{\partial f}{\partial x_i}\,\sigma_{x_i}\right)^2}$$

- **Variables and units:**

- $R = f(x_1, \dots, x_n)$: computed quantity (units depend on context).
- σ_R (uncertainty in R): same units as R.
- x_i: each measured input (with units, e.g. meter, second).
- σ_{x_i}: standard uncertainty in x_i (same units as x_i).
- $\partial f / \partial x_i$: partial derivative of f with respect to x_i (units of R per unit x_i).

- **Assumptions/scope:** Input uncertainties are **uncorrelated** and random (no covariances). The formula uses **standard deviations (1σ)**. It assumes errors are small so linear approximation holds. Only use for well-behaved functions (no discontinuities). **Scope for FE:** Steady error propagation; we do not cover full statistical theory.

- **Limit tests:**

- If one input uncertainty $\sigma_{x_i} \to 0$, that term drops out; if *all* inputs have 0 uncertainty, then $\sigma_R = 0$ (as expected).
- For a sum/difference $R = x_1 \pm x_2$, it reduces to $\sigma_R = \sqrt{\sigma_{x1}^2 + \sigma_{x2}^2}$.

- **Use vs. sibling formulas:** Use this general equation rather than (for example) treating errors linearly or just adding them. It replaces naive methods like summing absolute errors.

- **Common exam traps:** Forgetting to square the derivatives and uncertainties. Confusing absolute vs. relative uncertainty rules. Using the formula with correlated inputs (the exam will specify uncorrelated, so assume it unless given a covariance). Failing to re-evaluate partial derivatives correctly (especially if f has exponents or roots).

Exam Handbook Search Cues (Not affiliated with or endorsed by NCEES): *"Kline–McClintock", "error propagation", "uncertainty of a function"*. These will point you to the propagation formula.

Notes: This formula uses σ notation, but on the exam handbook it might use u or simply use "uncertainty". Units: σ_R inherits R's units. If you compute relative contributions, watch unit consistency: $\partial f / \partial x_i$ often has mixed units. Always attach units when summing under the square root.

Variations / Special Forms:

- **Sum/Difference:** If $R = x_1 \pm x_2$, then $\sigma_R = \sqrt{\sigma_{x1}^2 + \sigma_{x2}^2}$ (since $\partial R / \partial x_i = 1$). In general, for any linear combination $R = ax_1 + bx_2 + \cdots$, $\sigma_R = \sqrt{a^2\sigma_{x1}^2 + b^2\sigma_{x2}^2 + \cdots}$.

- **Product/Quotient:** If $R = x_1 \times x_2$ or x_1/x_2, use relative uncertainties:

$\left(\frac{\sigma_R}{R}\right)^2 = \left(\frac{\sigma_{x_1}}{x_1}\right)^2 + \left(\frac{\sigma_{x_2}}{x_2}\right)^2$. (Here $\partial f / \partial x_i$ leads to that result.)

- **Power law:** If $R = x^n$, then $\frac{\sigma_R}{R} = |n| \frac{\sigma_x}{x}$.

- **Typical values:** Coverage factor $k = 2$ (~95% confidence) doubles the standard uncertainty. So a result of $R \pm 0.5$ (1σ) could be reported as $R \pm 1.0$ at 2σ.

- **Negligible terms:** If one input's uncertainty is much smaller, it contributes little. The root-sum-square automatically weights larger uncertainties.

Special notes (calculator): To compute σ_R on calculators, you will square each term and sum. For example, enter (dx*ux)^2 etc., then press square-root. On calculators: ensure you use parentheses correctly. Example Casio syntax: sqrt((df/dx*ux)^2+(df/dy*uy)^2).

Explanation & Analysis: This formula is the heart of uncertainty analysis. Use it whenever a result depends on multiple measurements. Derivation is beyond exam scope, but the key is: each input's uncertainty *propagates* through the partial derivative $\partial f / \partial x_i$. For instance, if $R = x_1^2 x_2$, then $\partial R / \partial x_1 = 2x_1x_2$, $\partial R / \partial x_2 = x_1^2$. The uncertainty contributions are $2x_1x_2\,\sigma_{x1}$ and $x_1^2\,\sigma_{x2}$. Squared and summed under a square root give σ_R.

Term-by-term: - σ_{x_i} (units of x_i): the input standard uncertainty. - $\partial f / \partial x_i$ (units of R/x_i): sensitivity of R to x_i. E.g. if doubling x_i doubles R, derivative factor = 2. - Product $(\partial f / \partial x_i)\sigma_{x_i}$ has units of R; square it gives variance contribution. A common error is missing factors of 2 or forgetting that the chain rule may produce extra terms (e.g. derivative of x^2 gives 2x, not just x).

Finally, after computing σ_R, you often express the result as $R \pm \sigma_R$. If a 95% confidence interval is required, multiply σ_R by 2 (approx.). Always check units consistency: both value and uncertainty should use the same units and same number of significant figures (see next subtopic).

K13.T04.S11 – Significant Figures (Reporting Rules)

- **Concept:** Significant figures (sig figs) are rules for rounding numbers to reflect precision. They ensure your reported result isn't written with unrealistic precision. FE solutions usually keep 3–4 sig figs in the final answer.
- **Intuition:** The number of significant digits in a result should match the *least* precise input. For multiplication/division, it's the input with the fewest sig figs; for addition/subtraction, it's the least decimal places.
- **Context:** After computing an answer and its uncertainty, you must round properly. The exam handbook lists general rules for sig figs (Rules 1–6 on page 2).
- **Use:** Apply these rules when expressing your final "value ± uncertainty." For example, if uncertainty is 0.0513, you might round it to 0.05 (two sig figs) and round the main value to match (say 2.345 ± 0.05).

Definition Passport: *Significant Figures*

- **Definition:** A system of rules that determines how many digits in a number are meaningful, based on precision. Non-zero digits always count; zeros may or may not depending on position.

- **Exam impact:** Used in final answers and intermediate steps. The handbook rules (e.g. "least decimal places" for addition) are your guide.

- **Pitfall:** Common slip: forgetting to apply different rules for add/sub vs. mult/div. Another trap is carrying too many insignificant digits (calculator can show 10 digits but don't report all).

- **Quick check (T/F):** *If you multiply 3.40 (3 sig figs) by 2.1 (2 sig figs), the result should have 2 sig figs.* **True**.

Exam Handbook Search Cues (Not affiliated with or endorsed by NCEES): *"significant figures"*, *"rule 4: addition"*, *"rule 5: multiplication"*. These key phrases will lead you to the list of rules.

Notes: When showing work, intermediate steps can keep extra digits, but the final answer must follow sig-fig rules. By convention (rule 6), giving **3–4 sig figs** in the final result is safe. If an uncertainty is given, round it to 1–2 sig figs and round the main value to the same decimal place.

Variations:

- **Addition/Subtraction rule:** The result is rounded to the least number of decimal places in any addend. For example, 12.345 (3 d.p.) + 0.6 (1 d.p.) = 12.945, round to 12.9 (1 d.p.).
- **Multiplication/Division rule:** The result has as many sig figs as the factor with the fewest sig figs.
- **Exact values:** Constants like π (3.14159…) or defined quantities (1 ft = 12 in) are not counted in sig figs rules.
- **Typical use:** If your calculated uncertainty is 0.01427, you would usually write it as 0.014 (two sig figs) and match the main value accordingly.

Special notes: On calculators, you might see "2.0000001". Don't just copy that; round off as needed. On TI/HP calculators, you cannot directly set sig-figs, so use the approximate value and then round manually in your answer.

Explanation & Analysis: Significant figures help prevent false precision. They stem from measurement uncertainty: you can't credibly report more digits than the measurement warrants. In the context of uncertainty: if $\sigma_R = 0.85$, you shouldn't write 12.475 ± 0.847; you'd round to 12.48 ± 0.85 (two decimal places). Always double-check that the number of digits in the result is consistent with the input precision.

In summary, for FE Mechanical exam problems on uncertainty: identify uncertainties in givens, apply the Kline–McClintock formula to compute the combined uncertainty, then report the result with correct significant figures. These steps, combined with fluent use of exam handbook keywords, will ensure a complete and accurate answer.

DON'T MOVE ON YET!

Work Through Some Solid Practice Problems
while the Material of this Knowledge Is Still Fresh
THIS IS HOW THE CONCEPTS LOCK IN.

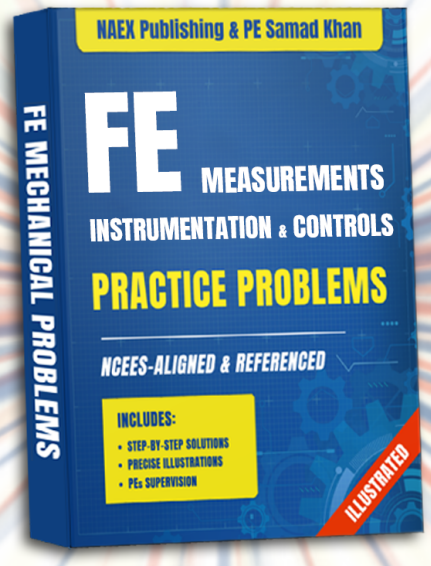

CLICK HERE TO PRACTICE

You'll be taken to our Discord Server, where the problems are located.

KNOWLEDGE 14

MECHANICAL DESIGN AND ANALYSIS

- NAEX Publishing -

"This publication is not affiliated with or endorsed by NCEES".

Topic 01 - Stress Analysis of Machine Elements

Topic Introduction: In mechanical systems, **stress analysis of machine elements** focuses on determining whether components like shafts, axles, and bearings can safely carry the applied loads without failure. This topic is crucial on the **FE Mechanical Exam** because it underpins many design questions – from checking if a shaft will yield under combined bending and torsion, to ensuring a rotating shaft won't fail from fatigue, to sizing a bearing for a required life. You'll often encounter problems asking for the **stress in a shaft** (or the factor of safety) under given loads, or the **required shaft diameter** for a specified load and material. Similarly, exam questions may ask you to compute **bearing reaction forces** and then determine the **bearing life** or required load rating. Mastering this topic means you can confidently apply formulas for torsional shear stress, bending stress, combined stress (like **von Mises** stress), fatigue criteria (like **Goodman/Soderberg** diagrams), and bearing life calculations. These are the bread-and-butter of machine design problems – and getting them right on exam day is key to avoiding over-designed (too heavy) or under-designed (unsafe) components.

K14.T01.S01 – Shafts and Axles (Static Loading)

Principle Introduction (Static Loading of Shafts): Shafts and axles under static loads experience internal stresses due to torque, bending moments, and sometimes axial forces. In static analysis (non-fluctuating loads), the goal is to ensure the material's yield strength is not exceeded (i.e. no permanent deformation):

- **Torsion in circular shafts:** A torque T causes a *shear stress* that varies linearly with radius. The maximum shear occurs at the outer surface: $\tau_{\max} = \frac{T\,c}{J}$, where c is the outer radius and J is the polar moment of inertia. For a solid circular shaft, $J = \frac{\pi d^4}{32}$ and $c = d/2$, so $\tau_{\max} = \frac{16T}{\pi d^3}$.

- **Bending in shafts:** A transverse load or moment M on a shaft causes a *normal stress* that is tensile on one side and compressive on the opposite. The bending stress is $\sigma = \frac{Mc}{I}$, max at the surface (c). For a solid round cross-section ($I = \frac{\pi d^4}{64}$), $\sigma_{\max} = \frac{32M}{\pi d^3}$. If an axial force F is also applied, add the uniform normal stress $\sigma_a = \frac{4F}{\pi d^2}$.

- **Combined loading:** At a given critical point on the shaft (usually the surface at a location of highest bending moment and torque), there will be *simultaneous normal stress* (from bending/axial) and *shear stress* (from torsion). To assess yielding, these combined stresses are translated into an equivalent single value using a failure theory. Ductile materials typically use **von Mises** (energy) criterion, while the **maximum shear stress** (Tresca) criterion provides a conservative alternative. Both require combining bending and torsional effects.

- **Design for static strength:** We calculate the shaft's **von Mises stress** or **maximum shear stress** and compare it to the yield strength (dividing yield strength by a factor of safety if specified). If the equivalent stress exceeds allowable stress, the shaft needs a larger diameter or stronger material. Static loading questions often involve solving for stress or checking yield conditions under a given set of loads.

Exam Handbook Search Cues (Not affiliated with or endorsed by NCEES): "torsional shear stress", "bending stress in shaft", "combined stress shaft", "von Mises yield criterion", "maximum shear stress theory".

Key Footnotes: - Always use **consistent units** (e.g. N·m for moments and Pa for stresses in SI). For USCS, convert torques to e.g. in·lb and use diameters in inches to get stress in psi. - Formulas above assume a **circular cross-section** (common for shafts). Other cross-sections have different I and J. - These formulas assume **linear elastic behavior** (Hooke's law holds) and that the shaft is not close to buckling (axial loads are modest). - "Static" here means loads do not cycle repeatedly. If loads fluctuate, fatigue (next subtopic) governs design instead of yield strength.

Variations & Related Forms:

- For **hollow shafts**, the same stress formulas apply ($\tau = Tc/J$, $\sigma = Mc/I$), but use the hollow section's I and J. A thin-walled hollow shaft has $J \approx 2\pi r^3 t$ (with r mean radius and t wall thickness).

- The **Tresca (maximum shear)** yield criterion for combined bending/torsion gives a slightly different equivalent stress measure than von Mises. It predicts yielding when $\tau_{\max}$ (half the difference between principal stresses) reaches $\frac{S_y}{2}$. In a shaft with normal stress σ and shear τ, Tresca's criterion can be expressed as $\tau_{\max}^{(\text{Tresca})} = \frac{1}{2}\sqrt{\sigma^2 + 4\tau^2}$.

- If there is **no torsion** ($T = 0$), the problem reduces to pure bending or axial loading, and you would just use $\sigma = \frac{32M}{\pi d^3} + \frac{4F}{\pi d^2}$ for the normal stress (shear stress zero). If there is no bending ($M = 0$), it reduces to pure torsion (use $\tau = \frac{16T}{\pi d^3}$) combined with any axial stress.

- **Stress concentrations:** Real shafts often have shoulders, keyways, etc. Under static loading, use a stress concentration factor K_t to multiply the nominal σ or τ. (In static analysis we usually ensure even the peak stress $K_t\sigma$ stays below yield, though for ductile materials with small notches, sometimes yielding at a notch is acceptable.)

Special Notes: For calculator use, combined stress formulas involve square roots – ensure you include the entire expression under the sqrt. For example, input von Mises as sqrt(sigma^2 + 3*tau^2). It's easy to make a parenthesis error under exam pressure, so double-check the grouping.

Equation Passport: Von Mises Combined Stress – calculates an equivalent single stress to compare against yield for a point under a combined normal stress σ and shear stress τ. This is based on the distortion energy theory (von Mises criterion) for yield.

$$\sigma_v = \sqrt{\sigma^2 + 3\tau^2}.$$

- σ_v **(von Mises stress)** – the equivalent stress (Pa or psi) that, if it were a simple tension, would produce the same distortion energy as the actual combined state.
- σ **(normal stress)** – the normal stress at the point of interest (Pa). For a shaft, this is typically the outer-fiber stress from bending plus any axial stress (tension or compression).

- τ **(shear stress)** – the shear stress at the same point (Pa), usually due to torsion in the shaft.

Assumptions & Validity: - The material is **ductile** and yields according to von Mises criterion (a good assumption for steel, aluminum, etc.). - Only one significant normal stress component and one shear component are active (as in a shaft loaded in bending and torsion). Other perpendicular stresses are zero. - **Static loading** – no fatigue factor is included here (use fatigue criteria separately for cycling loads). - The formula is used to **check yield**: typically, require $\sigma_v \leq S_y$ (or $\sigma_v \leq S_y/n$ for safety factor n).

Limit Checks: If $\tau = 0$ (no shear), then $\sigma_v = |\sigma|$ – it correctly reduces to the simple tensile/compressive stress. If $\sigma = 0$ (no bending/axial load), then $\sigma_v = \sqrt{3}\,|\tau|$, meaning pure shear stress is "equivalent" to a normal stress $\sqrt{3}$ times larger. (This $\sqrt{3}$ factor is why yielding in pure shear occurs at $\tau \approx 0.577 S_y$ for von Mises.)

Use vs. Alternatives: Use σ_v for designing shafts and other parts against yielding under combined loads. **Do not confuse it with** $\tau_{\max}$ **(Tresca)** – both are used for yield checks, but von Mises is a closer match to real ductile behavior. Tresca's maximum shear stress theory is more conservative; it would suggest yield when σ_v reaches about 0.95 of S_y for a given state (since Tresca's yield criterion is $\sigma_1 - \sigma_3 = S_y$, which gives a slightly larger required σ_v to yield).

Common Exam Traps:

- **Missing the 3x factor:** A frequent mistake is to forget the factor of 3 under the square root for the shear term. Remember that von Mises formula has $3\tau^2$, not just $\sigma^2 + \tau^2$.

- **Mismatched units:** Ensure that σ and τ are in the same units before plugging in. For example, if M is given in kN·m and d in mm, convert to N·m and m (or consistently to N and mm) to compute stress in Pa (or MPa). Likewise, don't mix psi and Pa.

- **Using the wrong stress components:** σ in this formula is the stress *along the shaft's axis* at the point of interest, and τ is the shear on the cross-section at that point. Don't plug in a bending stress from a different location than the torsion stress – you must evaluate both at the same material point.

- **Ignoring stress concentrations:** If a problem gives a stress concentration factor K_t for a shoulder or keyway, multiply σ (for bending/axial) or τ (for torsion) by K_t *before* using the von Mises equation. The exam might explicitly mention this in a question.

Explanation & Analysis: In practice, to analyze a shaft for static loading, you first compute the individual stresses from each load. For example, find the bending stress at the shaft's surface using $\sigma = Mc/I$, and the torsional shear using $\tau = Tc/J$. Then you combine them via von Mises (or Tresca). Term by term, σ^2 represents the energy from the normal stress and $3\tau^2$ represents the energy from shear (with the factor 3 coming from the geometry of stress in 3D). By taking the square root, you get a single "equivalent" stress σ_v. You would compare σ_v to the yield strength S_y of the material. For instance, if a steel shaft has $S_y = 250$ MPa and you found $\sigma_v = 200$ MPa under the given loads, the shaft is safe (no yield, with a margin). But if σ_v came out to 270 MPa, it exceeds yield – so the shaft would need a larger diameter or material with higher S_y. On the exam, common mistakes include arithmetic errors (forgetting to square a term or take the sqrt) and sign confusions (tensile vs compressive bending stress – but since we square σ, the sign won't matter for von Mises). However, if a question specifically asks for **principal stresses** or **maximum shear stress**, you might need to compute those via Mohr's circle or formula – but usually the exam focuses on using von Mises or comparing against yield directly. Finally, remember to clearly distinguish **factor of safety** problems: if asked for a factor of safety, you'd compute FOS $= \frac{S_y}{\sigma_v}$ (or $\frac{S_y}{2\tau_{\max}}$ for Tresca), assuming elastic behavior.

K14.T01.S02 – Shafts and Axles (Fatigue Loading)

Principle Introduction (Fatigue in Rotating Shafts): When shafts are subjected to **repeated or fluctuating loads**, even stresses well below the yield strength can cause failure after many cycles. This failure mode is **fatigue**. For rotating shafts, *bending stresses* typically fluctuate from tension to compression as the shaft rotates (a point on the surface goes from the "top" in tension to the "bottom" in compression each half rotation), and *torsional stresses* may fluctuate or remain steady depending on loading:

- **Fully reversed bending:** A shaft in bending (e.g., a rotating shaft with a constant transverse load) experiences an alternating stress range from $+\sigma_b$ to $-\sigma_b$ at the surface. The stress amplitude σ_a equals the bending stress (and mean $\sigma_m \approx 0$). This alternating stress can cause fatigue crack initiation over time.

- **Torsional fatigue:** Pure steady torque on a rotating shaft actually produces a **steady shear stress** in the material's local frame (since the shear direction rotates with the shaft). Thus, a constant torque contributes mostly a *mean stress* component in shear (with $\tau_m \neq 0$, but $\tau_a \approx 0$ for steady torque). If torque itself fluctuates (e.g., an engine crankshaft under varying load), then it adds an alternating shear component as well.

- **S–N curve (Wöhler curve):** Materials (especially steels) have characteristic stress-vs-life curves. In lab tests, specimens are subjected to cyclic stress amplitudes until failure, and the number of cycles N to failure is recorded. Plotting stress amplitude (S) against cycles (N) typically yields a decreasing curve. Steel and other ferrous alloys exhibit an **endurance limit** S_e – a stress amplitude below which the material can endure essentially infinite cycles without failing. For example, a steel might have $S_e \approx 0.5\,S_{\text{ult}}$. Non-ferrous metals (aluminum, etc.) do not have a true endurance limit; they fail eventually at any stress, though a "fatigue strength at 10^8 cycles" is used instead.

- **Goodman and Soderberg criteria:** When a **mean stress** is present (not fully reversed loading), it reduces the allowable alternating stress for a given life. This is often visualized on a **Goodman diagram** (alternating stress vs. mean stress). The **Goodman line** is a straight line from S_e (at zero mean stress) down to S_{ult} (at zero alternating stress). The **Soderberg line** is even more conservative, going from S_e to S_y (yield strength). Any operating point below these lines is considered safe from fatigue; any point above could cause fatigue failure. In practice, design for infinite life often uses the Soderberg or modified Goodman (which uses S_{ult}) criterion to include mean stress effects.

- **Combined loading fatigue (Shafts):** For a rotating shaft with both bending and torsion, we combine their alternating components and mean components. A common approach (used in the exam **reference handbook**) is the **Soderberg criterion with maximum shear theory** (sometimes called the Westinghouse formula). This method ensures infinite life by applying the Soderberg relation **within each component** (mean + alternating in bending, mean + alternating in torsion), then combining bending and torsion using an **RMS/elliptic (root-sum-square)** relationship. Essentially, the

bending and torsion each contribute to fatigue damage, and mean stresses (steady components) also consume part of the "strength budget." We use fatigue stress concentration factors (K_f, K_{fs}) in these calculations to account for notches.

Exam Handbook Search Cues (Not affiliated with or endorsed by NCEES): "fatigue stress", "S–N curve", "endurance limit", "Goodman diagram", "Soderberg line", "Westinghouse shaft formula".

Key Footnotes:

- **Fatigue strength reduction:** Be aware if the problem provides factors for surface finish, size, reliability, etc. The FE Exam **typically doesn't require** applying these modifiers explicitly unless given. Usually, you'll be given an effective endurance limit or told to assume a percentage of ultimate strength.

- **Mean stress effects:** If the problem explicitly mentions **Goodman** or **Soderberg**, use the corresponding line. Goodman uses S_{ult} (ultimate strength) in the relationship, Soderberg uses S_y (yield). The exam might specify which approach or simply give you the formula. - **Cycles to failure:** While infinite life design (staying below S_e) is common, the exam could ask for *finite life*. In that case, you might use the S–N curve data: e.g. "Given a stress amplitude, estimate the number of cycles to failure from the graph/data." Interpolation might be needed if they provide two points on an S–N chart. Always use log-log interpolation on S–N plots (since they're usually plotted log-log).

- **Fracture vs yield:** Fatigue failure is brittle-like (sudden), so it doesn't matter if nominal stress is below yield; cracks can grow. So don't use yield strength for alternating stresses (except as it appears in Soderberg's very conservative line).

- **Safety factors in fatigue:** Sometimes a factor of safety is applied to fatigue loading as well. Be clear whether an "n" given in a fatigue problem is a factor on life or on stress. Typically, n in a fatigue formula (like in Soderberg equation below) is used as a safety factor on stress amplitude (i.e., design for longer life than borderline).

Variations & Related Forms:

- **Goodman vs. Gerber:** The Goodman relation (linear) is a simpler approximation. There's also **Gerber's parabola**, which is a curved criterion using S_{ult} (more accurate for mid-range mean stresses but not usually needed on FE). Unless a problem specifically provides a Gerber equation, stick to linear Goodman or Soderberg.

- **Fatigue stress concentration (K_f):** This accounts for the fact that a notch's effect on fatigue is less severe than on static strength (due to plasticity at the notch root). If K_t is the geometric stress concentration factor, often you'll be given a fatigue notch factor K_f (with $1 < K_f < K_t$). Use K_f in fatigue stress calculations (e.g., use $K_f M$ for alternating bending moment to get an effective σ_a).

- **Mean stress in torsion:** For a shaft under steady torque and cyclic bending, the shear stress from torque is a *mean* shear stress (non-zero mean, zero alternating if torque is constant). Many fatigue theories require converting shear stress to an equivalent normal stress. Using Tresca (max shear) theory, one might treat the shear stress as an equivalent normal stress of the same magnitude for alternating comparison. The provided formula below handles this by separate bending and torsion terms.

- **Low-cycle fatigue vs high-cycle:** The formulas and S_e assume high-cycle (typically >~10,000 or 100,000 cycles). If a problem were explicitly low-cycle (high stress, <1000 cycles), plastic strain and Coffin-Manson relations come into play – but that's beyond FE scope unless merely definitional.

Special Notes: When using the allowed FE exam calculators for fatigue problems, be careful to enter complex expressions step by step. It can help to compute partial sums (e.g., calculate $\frac{M_a}{S_e}$, $\frac{M_m}{S_y}$, etc. individually) to avoid confusion. Also, remember that if a problem gives **alternating stress** and **mean stress** directly (instead of loads), you can plug those into Goodman/Soderberg equations without recomputing from moments.

Goodman (Smith) Diagram for Fatigue: This diagram illustrates how **mean stress** reduces the allowable **alternating stress** for infinite-life fatigue design. The x-axis shows the mean stress σ_m(MPa), and the y-axis shows the stress amplitude σ_a(MPa). The blue line is the Modified Goodman line, extending from $\sigma_a = S_e$ at $\sigma_m = 0$(fully alternating, zero mean) to $\sigma_a = 0$ at $\sigma_m = S_{ult}$. The **red dashed line** is the Soderberg line, which instead drops to $\sigma_m = S_y$. Any operating point beneath these lines is considered safe for infinite fatigue life. For example, at zero mean stress you can allow up to S_e amplitude; at a mean stress equal to $0.5S_{\text{ult}}$, Goodman's line would allow a certain fraction of S_e as σ_a.

- **Axes and Units:** Mean stress σ_m is plotted on the X-axis (zero at left, increasing to the right up to the material strength), and alternating stress σ_a on the Y-axis (zero at bottom, increasing upward). Stresses are in the same units (e.g. MPa or psi). The diagram is often normalized, so 1.0 on axes corresponds to material strengths (S_e, S_y, S_{ult}).
- **Key Regions:** The region **below** both lines (toward the origin) is safe. The area above the Goodman line is unsafe (fatigue failure expected). The area between Soderberg (red) and Goodman (blue) reflects designs that Goodman would judge safe but Soderberg (more conservative) would not – often designers choose somewhere between for a safety margin. The **endurance limit** S_e is marked on the vertical axis (this is the maximum completely reversing stress the material can indefinitely withstand). The intercept on σ_m axis is either S_{ult} (Goodman) or S_y (Soderberg).
- **Using the Diagram:** A problem might give σ_m and σ_a and ask if infinite life is expected. Plotting that point or, more practically, checking the inequality $\frac{\sigma_a}{S_e} + \frac{\sigma_m}{S_{\text{ult}}} \leq 1$ (Goodman) tells you if it's below the line (safe). If using Soderberg, use S_y instead of S_{ult}. On the exam, you'll typically directly apply the formula rather than actually graphing points.
- **Common Misinterpretations:** One common mistake is to use the **wrong strength value** – e.g., plugging S_y when the problem implies using ultimate strength (or vice versa). Another is forgetting that S_e is much lower than S_{ult} (for steels ~ half of S_{ult}): if you erroneously use S_{ult} in place of S_e, you'll severely overestimate fatigue capacity. Also, remember that this diagram (and formulas derived from it) assume **infinite life** criteria. If a question is about finite life (e.g., will it survive 10^5 cycles?), then you might need to use the actual S–N curve data instead of these linear extrapolations.

Equation Passport: Westinghouse / Soderberg Shaft Fatigue (FE form; combined bending + torsion) – Apply Soderberg

inside each component (mean + alternating), then combine bending and torsion using an **RMS/elliptic (root-sum-square)** relationship:

$$\frac{\pi d^3}{32} = n_s \sqrt{\left(\frac{M_m}{S_y} + \frac{K_f M_a}{S_e}\right)^2 + \left(\frac{T_m}{S_y} + \frac{K_{fs} T_a}{S_e}\right)^2}$$

Solve for d(common exam use):

$$d = \left[\frac{32\, n_s}{\pi} \sqrt{\left(\frac{M_m}{S_y} + \frac{K_f M_a}{S_e}\right)^2 + \left(\frac{T_m}{S_y} + \frac{K_{fs} T_a}{S_e}\right)^2}\right]^{1/3}$$

- d – shaft diameter (m).
- n_s – desired fatigue factor of safety (dimensionless).
- M_a – alternating component of bending moment (N·m). For a rotating shaft with a steady load, M_a is essentially the fully reversed bending moment (e.g., if a shaft sees bending of M in one direction, as it spins the surface point sees from $+M$ to $-M$, so $M_a = M$).
- M_m – mean (steady) component of bending moment (N·m). If the bending load doesn't reverse fully (or there's a constant offset), that constant part produces a mean stress.
- T_a – alternating component of torque (N·m). If torque fluctuates between a high and low value, T_a is half the range. If torque is constant in rotation, $T_a \approx 0$ (no alternating shear stress).
- T_m – mean (steady) torque (N·m). A constant operating torque contributes a steady shear stress (mean stress in shear) on the shaft.
- K_f, K_{fs} – fatigue stress concentration factors for *alternating* bending and *alternating* torsion, respectively (dimensionless). In the FE Westinghouse/Soderberg shaft-fatigue form, apply $K_f$to $M_a$and $K_{fs}$to T_a; mean terms use $M_m$and $T_m$directly unless a problem explicitly tells you otherwise.
- S_e – endurance limit of the material (Pa or psi). Use the **corrected** endurance limit for the shaft's size, surface finish, etc., if provided (otherwise the "ideal" lab value or a given value). This is the fully reversed **fatigue strength for infinite life**.
- S_y – yield strength of material (Pa or psi). Used here in the mean stress term for Soderberg's criterion (more conservative than using S_{ult} as Goodman does).
- (All strength values and moments should be in consistent units; S_e and S_y typically given in MPa or psi, and moments in N·m or lb·in to match.)

Assumptions & Scope:

- **Infinite life design:** This equation is aimed at avoiding fatigue failure indefinitely (usually $N > 10^6$ cycles). It uses S_e; if the expected life is finite (low cycle), this linear criterion wouldn't apply directly.

- **Soderberg within components + elliptic combination across components:** The Soderberg relation is **linear within bending** (mean + alternating) and **linear within torsion** (mean + alternating). Bending and torsion are then combined using an **RMS/elliptic** relationship (root-sum-square)."

- **Max-shear style combination (FE form):** bending and torsion contributions are combined via a **root-sum-square (elliptic)** relationship, rather than a single linear sum.

- **Steady loading with occasional fluctuations:** We assume the shaft operates at a mean load (M_m, T_m) with fluctuations (M_a, T_a). If loads were completely reversed (e.g., bending fully alternating, no mean), the formula still works (then M_m or T_m would be zero). If loads are non-zero mean and zero alternating (pure static load), this criterion defaults to requiring yield-level safety for static load. - **Single critical location:** We apply this equation at the most stressed location of the shaft (usually at a shoulder or where bending moment is highest). That point sees a certain M_a, M_m, T_a, T_m. We assume those can be treated as sinusoidal or steady components accordingly.

Limit Tests (using the FE elliptic form):

- If all alternating components are zero ($M_a = T_a = 0$):

$$\frac{\pi d^3}{32} = n_s \sqrt{\left(\frac{M_m}{S_y}\right)^2 + \left(\frac{T_m}{S_y}\right)^2} = \frac{n_s}{S_y}\sqrt{M_m^2 + T_m^2}$$

- If mean components are zero ($M_m = T_m = 0$, fully reversed loading):

$$\frac{\pi d^3}{32} = n_s \sqrt{\left(\frac{K_f M_a}{S_e}\right)^2 + \left(\frac{K_{fs} T_a}{S_e}\right)^2} = \frac{n_s}{S_e}\sqrt{(K_f M_a)^2 + (K_{fs} T_a)^2}$$

- Pure bending only ($T_a = T_m = 0$) reduces to

$$\frac{\pi d^3}{32} = n_s \left| \frac{M_m}{S_y} + \frac{K_f M_a}{S_e} \right|$$

- and pure torsion only ($M_a = M_m = 0$) reduces to

$$\frac{\pi d^3}{32} = n_s \left| \frac{T_m}{S_y} + \frac{K_{fs} T_a}{S_e} \right|$$

Use vs. Sibling Equations: Use this **Soderberg combined equation** when you need a quick, conservative design check for a shaft under fluctuating loads (common in exam references). "A **Goodman** version keeps the same elliptic combination but uses S_{ult}in the **mean** terms:

$$\frac{\pi d^3}{32} = n_s \sqrt{\left(\frac{M_m}{S_{ult}} + \frac{K_f M_a}{S_e}\right)^2 + \left(\frac{T_m}{S_{ult}} + \frac{K_{fs} T_a}{S_e}\right)^2}$$

(Any algebraically equivalent form is fine.)"

The exam will indicate which to use by giving (or referencing) **yield strength** for Soderberg or **ultimate strength** for Goodman. The fatigue safety factor $n_s$is applied in the same place in both forms.

Common Exam Traps:

- **Forgetting to divide by n (or including it incorrectly):** If asked for a factor of safety, you might set up the equation without $n = 1$ to solve for n. Conversely, if given n, include it in the equation. It's easy to mix up whether n is in numerator or denominator – our equation is arranged so that if everything is exactly at the fatigue limit, the left side = $1/n$ (and we set it equal to 1 for safety).

- **Mixing up K_t and K_f:** K_t (the theoretical stress concentration factor) is larger; K_f (fatigue notch factor) is used in fatigue calculations. If only K_t is given on the exam and no notch sensitivity, using K_t in place of K_f makes the design more conservative (which is safe). But if K_f is given, use it – it accounts for the notch effect in fatigue.

- **Incorrect strength values:** Sometimes S_e needs to be obtained or adjusted. If the problem gives ultimate strength and says "assume a fully corrected endurance limit is 0.5 S_{ult}," use that for S_e. Don't plug S_{ult} itself in place of S_e – endurance limit is much lower. And if the shaft is not rotating-bending (for example, if it's a non-rotating part with fluctuating load), the endurance limit concept still applies but context matters (rotating beam test is baseline for S_e).

- **Unit confusion in formula:** Ensure M_a, M_m, T_a, T_m are in consistent units with S_e and S_y. For instance, if moments are in N·m, convert them to N·mm only if you convert S_e to N/mm² (MPa) consistently (since $\pi d^3/16$ if d in mm will yield mm³, matching MPa which is N/mm²). It might be easier to stick to SI base: d in m, moments in N·m, strengths in Pa; the equation will work giving a dimensionless result = 1.

Explanation & Analysis: To use the above fatigue criterion step-by-step, follow a structured approach:

(1) Identify the alternating and mean components of load. For example, if a shaft has a bending moment that fluctuates between +100 N·m and -100 N·m, then $M_a = 100$ N·m (the amplitude) and $M_m \approx 0$. If a torque oscillates between 50 and 150 N·m, then the mean torque $T_m = 100$ N·m and the alternating part $T_a = 50$ N·m.

(2) Apply any given **fatigue stress concentration factors**: multiply M_a by K_f and T_a by K_{fs}; use M_m and T_m directly unless the problem explicitly instructs otherwise.

(3) Compute

$$A = \frac{M_m}{S_y} + \frac{K_f\, M_a}{S_e}, B = \frac{T_m}{S_y} + \frac{K_{fs}\, T_a}{S_e}$$

then combine them as $\sqrt{A^2 + B^2}$ and use the FE relation

$$\frac{\pi d^3}{32} = n_s\sqrt{A^2 + B^2}.$$

If you want it in one single line (calculator-friendly), use:

$$\frac{\pi d^3}{32} = n_s\sqrt{\left(\frac{M_m}{S_y} + \frac{K_f M_a}{S_e}\right)^2 + \left(\frac{T_m}{S_y} + \frac{K_{fs} T_a}{S_e}\right)^2}.$$

(4) Solve for the unknown. Often you'll solve for d (the minimum shaft diameter for infinite life). Since d^3 is in the equation, you'd isolate d^3 and then take the cube root. Sometimes you might solve for n to find the factor of safety given an existing d. Either way, be careful with algebra and keep track of units (it's wise to convert everything to, say, N·mm and MPa to avoid scientific notation errors).

For example, suppose a steel shaft has $S_e = 200$ MPa, $S_y = 300$ MPa, and is subjected to an alternating bending moment of $M_a = 500$ N · m and a steady torque of $T_m = 400$ N · m. Let $M_m = 0$, $T_a = 0$, $K_f = 1.5$, $K_{fs} = 1.2$, and $n_s = 2$. Convert moments to N·mm: $M_a = 5.0 \times 10^5$ N · mm, $T_m = 4.0 \times 10^5$ N · mm (since 1 MPa = 1 N/mm²).

Compute:

$$A = \frac{M_m}{S_y} + \frac{K_f M_a}{S_e} = \frac{0}{300} + \frac{1.5(5.0 \times 10^5)}{200} = 3750 \text{ mm}^3$$

$$B = \frac{T_m}{S_y} + \frac{K_{fs} T_a}{S_e} = \frac{4.0 \times 10^5}{300} + 0 = 1333.3 \text{ mm}^3$$

Then

$$\sqrt{A^2 + B^2} = \sqrt{(3750)^2 + (1333.3)^2} \approx 3980 \text{ mm}^3$$

Using the FE relation $\frac{\pi d^3}{32} = n_s\sqrt{A^2 + B^2}$,

$$d^3 = \frac{32 n_s}{\pi}(3980) = \frac{64}{\pi}(3980) \approx 8.11 \times 10^4 \text{ mm}^3$$

$$d \approx 43.3 \text{ mm}.$$

Finally, remember that fatigue problems can be involved – identify what the question is specifically asking (required diameter? factor of safety? cycles to failure?) and focus on the appropriate formula. If they give you a fully reversed stress and an S–N curve, you *might not* need the big combined formula – you might just read off life. Conversely, if they mention "Goodman diagram" or give mean stress, you know you should use a criterion like the one above. Practice recognizing these cues to efficiently pick the right approach on exam day.

K14.T01.S03 – Bearing Loads and Life Calculation

Principle Introduction (Bearing Loads and Life): Rotating shafts are supported by bearings, and those bearings must be selected to handle the forces and last a required duration. **Bearing load analysis** involves two main steps: (1) determine the forces acting on each bearing due to the shaft's loads (gears, pulleys, etc.), and (2) use those forces to select a bearing with an adequate fatigue life (or calculate the bearing's life).

Key points:

- **Reaction forces on bearings:** Treat the shaft like a statically determinate beam. Forces from gears and pulleys on the shaft create reactions at the support bearings. For example, a gear transmitting torque creates a tangential force W_t and possibly a radial force W_r on the shaft (due to the gear's pressure angle). These forces act at the gear location and are reacted by the bearings. Sum of forces and moments ($\sum F = 0, \sum M = 0$) will give the loads at the bearings. *Typical scenario:* A shaft with two bearings (one at each end) and a gear or pulley in between – the bearing closer to the load usually takes more of the force. If the load is centered, reactions might split evenly.

- **Gear forces:** For a spur gear on a shaft, the transmitted force W_t (tangential) can be found from the torque: $W_t = \frac{2T}{d_p}$ (where d_p is pitch diameter). The gear also exerts a radial force $W_r = W_t \tan\phi$ (with ϕ the pressure angle) that pushes the shaft sideways. These components act perpendicular to each other and both load the bearings (one may cause bending in one plane, one in another). A helical or bevel gear would add an axial thrust force as well (not just radial).

- **Belt and pulley forces:** A pulley or sprocket will have belt tension. Often one side of the belt is tighter than the other (transmitting torque), resulting in a net radial load on the shaft equal to the difference in belt tensions. If a problem gives belt tension values, the net downward force on the shaft = $T_{\text{tight}} - T_{\text{slack}}$.

If only one tension is given, sometimes assume the other is negligible for an approximate worst-case.

- **Bearing load combinations:** Bearings may carry a radial load F_r and an axial (thrust) load F_a. When both are present and the problem/reference requires combined-loading treatment, convert (F_r, F_a) into a single equivalent dynamic load P_{eq} using the coefficient-based equation provided by the permitted reference or by the problem statement. Then use P_{eq} in the life equation. If the problem explicitly instructs "assume pure radial loading" or "neglect thrust for life," follow that instruction and use the specified simplification.

- **Bearing life (fatigue life):** Standard rolling-contact bearings are rated by the **L10 life** – the number of rotations (or hours of operation at a certain speed) that 90% of a batch of bearings will survive under a given load. The relationship between load and life is **highly non-linear**: a slightly lower load greatly extends life. It is calculated using $L_{10} = (C/P)^a$, where C is the bearing's basic dynamic load rating (the load associated with a rating life of 1×10^6 revolutions) and a is the life exponent, 3 for ball bearings and $10/3$ for roller bearings. This means if you halve the load (P), the life increases by 2^a (a factor of 8 for ball bearings, since $a = 3$). Conversely, if you double the required life, the bearing must have a higher C such that (C/P) is the cube root of that life factor.

Exam Handbook Search Cues (Not affiliated with or endorsed by NCEES): "bearing reaction force", "gear tangential force", "bearing life equation", "basic load rating C", "equivalent radial load".

Key Footnotes:

- Bearing life is often given in **hours** in practical problems. To use $L_{10} = (C/P)^a$, you might need to convert hours to number of revolutions: $N_{\text{rev}} = (\text{RPM}) \times 60 \times (\text{hours})$. Then divide by 10^6 to express life in millions of revolutions (since L_{10} formula expects millions of rev). Many exam problems sidestep this by giving life directly in millions of cycles or asking for a ratio.

- The formula $L_{10} = (C/P)^a$ assumes **90% reliability**. If the exam asks about a different reliability (rarely, maybe L50 or so), that would be a different factor. But typically stick with L10 unless stated.

- Always clarify if P is **constant** or a maximum. The life equation assumes a constant equivalent load. If a bearing sees variable loads, one would need to do an equivalent load calculation (beyond FE scope unless trivialized). Likely the exam gives a single representative load or asks for life under that steady load.

- Use the correct exponent a: if the problem says "roller bearing," use $a = 10/3 \approx 3.33$. If not specified, assume ball bearing ($a = 3$) as a safe default (or deduce from context – e.g., most small to medium bearings are ball type unless noted).

- The **basic load rating** C is typically provided in manufacturer catalogs. If the exam problem gives you multiple choice of bearings with certain C values, you'd compute the required $C_{\min} = P \times L_{10}^{1/a}$ and pick a bearing with C equal or above that. Conversely, if they give a specific bearing's C and ask how long it will last under a load P, plug into $L_{10} = (C/P)^a$.

- Watch units: C and P must be in the **same unit** (both N, both lbf, etc.) or the ratio will be off. No unit conversion is needed within $(C/P)^a$ as long as they match.

Variations & Related Forms: - Bearing life in hours: A useful form: $L_{10h} = \frac{10^6}{60\, N_{\text{rpm}}} \left(\frac{C}{P}\right)^a$ gives life in hours, where N_{rpm} is the rotation speed in RPM. This is derived from L_{10} in rev by dividing by revs per hour. If the exam question gives a required life in hours at a certain speed, you can use this directly. For instance, if a bearing must last 20,000 hours at 1800 rpm, that's $N = 20{,}000 \times 60 \times 1800 \approx 2.16 \times 10^9$ revolutions, or $L_{10} = 2160$ million rev. Plug that in to find needed C relative to P.

- **Static load rating (C_0):** Bearings also have a static rating C_0 for loads that cause a certain permanent deformation. The FE exam **usually emphasizes fatigue life** (dynamic load rating C). If a problem gives C_0, it might be to ensure the bearing can handle a shock load without brinelling. Unless explicitly asked, focus on C for life.

- **Thrust bearings:** If dealing with a pure thrust (axial) bearing, the life formula still holds, but P would be the axial load and X, Y factors would be set such that $P_{eq} = F_a$ effectively. Deep groove ball bearings can take some thrust, hence the need for X, Y factors. Pure radial bearings (like cylindrical rollers) cannot take much thrust – exam will usually not dive into that nuance unless theoretical.

- **Multiple bearings load sharing:** If the question involves, say, two bearings supporting a shaft, each bearing's load (and thus life) can be different. Typically, one bearing sees higher load (like the one closer to a gear's force). It's safest to calculate life for **each** bearing's load and identify the limiting one. If the exam asks "how long will the bearing last," they likely expect the worst-case (shorter life) unless a specific bearing is referenced.

Special Notes: In calculator, avoid raising large ratios to the 3.33 power in one step if possible (to reduce error). It can be easier to take logs or use successive multiplication: e.g., $(C/P)^{3.33} = (C/P)^3 \times (C/P)^{0.33}$. But most modern exam calculators can handle a single exponent just fine. Just be cautious of overflow if using non-SI units (pounds and maybe million cycles – keep numbers manageable by using scientific notation or simplifying the ratio before exponentiating).

Equation Passport: Bearing Load-Life Equation – relates the applied load on a bearing to its expected fatigue life (90% survival). It's used to either predict how long a bearing will last under a load, or to determine the required rating C for a desired life.

$$L_{10} = \left(\frac{C}{P}\right)^a$$

- L_{10} – the **bearing life** for 90% reliability, in **million revolutions** (dimensionless, effectively). For example, $L_{10} = 50$ means 50 million rev. If needed in hours, convert using rpm.
- C – **basic dynamic load rating** (N or lbf). This is a property of the bearing: the radial load that the bearing can endure for 1.0 million revolutions of life. Larger, higher-quality bearings have higher C values.
- P – equivalent dynamic load used in the bearing life equation (same force units as F_r and F_a). If combined radial + axial loading is to be included, compute P_{eq} using the coefficient form provided by the permitted reference or the problem statement: Template: $P_{eq} = X\, V\, F_r + Y\, F_a$. Use X, Y, and V exactly as provided for the bearing type and loading case. This guide intentionally does not reproduce coefficient tables or selection cutoffs for choosing those coefficients.

- a – **life exponent** (dimensionless). Determines how strongly life is affected by load. For ball bearings $a = 3$; for roller bearings $a = 10/3 \approx 3.33$. (Ball bearings are slightly more load-sensitive).
- V – rotation factor (dimensionless). Accounts for which bearing ring rotates relative to the load; use the FE handbook value (often V=1 when not otherwise specified).

Assumptions & Scope:

- The formula assumes **proper installation and alignment** of the bearing (no excessive misalignment or heat – those factors can drastically reduce life but are outside the basic formula).

- The load P is assumed to be a constant average load. Real machines have variable loads, but the method uses an equivalent constant load for life calculation. If loads fluctuate, one would use a weighted damage sum (not expected in FE exam unless trivialized).

- The bearing fails by **fatigue (spalling)** of the races/balls. Lubrication is adequate and operating conditions are normal – so we're not considering failure by lubrication starvation or contamination.

- 90% reliability (L10 life) is the standard. Some questions may mention **median life L50** (median life), greater than L_{10} (the exact ratio depends on the assumed life distribution); if a conversion is required, the problem or reference will supply the needed relationship.

Limit Checks: If $P = C$, then $\frac{C}{P} = 1$ and $L_{10} = 1^a = 1.0$ (million rev). This is by definition: the basic rating life is 1 million revolutions at load C. If P is only half of C, then $\frac{C}{P} = 2$ – for a ball bearing, $L_{10} = 2^3 = 8$ million rev (load halved $\Longrightarrow$ life is eightfold). If P is twice C (very heavy load), $L_{10} = (0.5)^3 = 0.125$ million rev (i.e. only 125,000 rev), illustrating the strong inverse relationship. As P approaches 0 (very light load), L_{10} theoretically goes to infinity – in practice, other factors (like lubrication, corrosion) will end life, but fatigue won't be the limiting factor at very low loads.

Use vs. Other Considerations: Use this equation for **fatigue life calculations of rolling bearings**. Note it does **not** cover plain bearings (which have a whole different hydrodynamic design approach) – but plain bearings are typically not in FE scope. If a question asks for a required bearing such as "select a bearing from catalog," you'd use this equation to find the minimum C needed, then choose a bearing whose C meets or exceeds that. Also, don't confuse this with the calculation of **bearing stresses** (e.g., contact stress) – that's a separate Hertz contact problem not usually needed in FE. Stick to the load-life relationship unless otherwise directed.

Common Exam Traps:

- **Forgetting to use equivalent load:** If thrust F_a is present and the problem indicates that combined loading must be considered for life, do not substitute F_r directly into the life equation. Compute the required equivalent load P_{eq} using the coefficient form and coefficients provided by the permitted reference/problem data, then use P_{eq} in the life calculation.

- **Mixing up units/time:** A classic mistake is to plug in life in hours directly for L_{10}, or to output life in revolutions when asked for hours. Remember: use L_{10} in *million revolutions*. If a bearing runs at 1800 rpm, in one hour it makes 108,000 revolutions, which is 0.108 million rev. A computed $L_{10} = 50$ (million rev) corresponds to about $50/0.108 \approx 463$ hours at that speed. If asked for hours, do that conversion at the end.

- **Rounding exponents:** If using $a = 10/3$, keep sufficient precision. It might be easier on the calculator to do $(C/P)^{3.333}$ directly. Alternatively, raise to the 10th power and take cube root, etc. Just be careful – small errors in exponent can lead to noticeable differences in life.

- **Selecting nearest bearing:** If a problem gives a table of bearings with their C values, you calculate a required $C_{\min}$. Don't forget to pick the next higher available C (bearing capacities are standardized). For example, if you compute $C_{\min} = 4.2$ kN and the catalog has bearings of 3.8 kN and 4.5 kN, you must choose the 4.5 kN one (the 3.8 kN would not meet the requirement). The exam may implicitly test this by including a too-low option.

- **Neglecting dynamic vs static load context:** The life equation only applies to dynamic (rotating) conditions. If a bearing is primarily loaded while static (e.g., oscillating or holding a heavy weight without rotating much), the static rating C_0 (and permissible static load factor) might govern. But FE problems typically stick to the fatigue life scenario for bearings unless explicitly stating otherwise.

Explanation & Analysis: To solve bearing problems on the FE exam, follow these steps:

(1) Determine bearing loads. Draw a free-body diagram of the shaft. Include forces from gears (tangential W_t and radial W_r), from pulleys (belt tension forces), etc., at their points of application. Apply equilibrium to find reactions at the support bearings. For instance, with a single force between two bearings, you'll do $\sum M$ about one bearing to find the reaction at the other. The result might be that one bearing carries, say, 70% of the load and the other 30%, depending on distances.

(2) Identify radial vs axial components. Typically, the vertical or lateral forces are radial loads on the bearing. If there's an axial force (along the shaft), one of the bearings (often a "thrust" or fixed bearing) will take it. The problem might specify which bearing takes the thrust.

(3) Compute equivalent load P (or P_{eq}). If the problem requires accounting for both radial and axial load components in bearing life, obtain the needed coefficients from the permitted reference or from the problem statement and compute P_{eq} using the provided coefficient equation. If the problem explicitly instructs to neglect axial load for life or assumes pure radial loading, apply that instruction directly (e.g., set $F_a = 0$ for the life calculation, or use the simplified P specified by the problem).

(4) Use the life equation. Plug into $L_{10} = (C/P)^a$. Determine what you need: If asked "how long (in hours) will it last?", compute L_{10} in rev then convert to hours. If asked "what C is required for a 50,000-h life at X rpm under this load?", compute the needed $C = P \times \left(L_{10,\text{req}}\right)^{1/a}$. Keep track of units – often easiest to convert everything to N and rev.

(5) Interpret the result. If you solved for life and got, say, $L_{10} = 100$ million rev, at 1800 rpm that's $\frac{100\times10^6}{1800\times60} \approx 925.9$ hours (which is about 38.6 days of continuous operation). Check if that seems reasonable for the problem context. If you solved for C and got 5000 N, make sure it's higher than P (it should be, otherwise life

would be <$1*10^6$ rev). In exam questions, common pitfalls are arithmetic (especially raising to a power). A quick way to check your life calculation: if you increase the load, life should drop dramatically. If your calculation shows life increasing with load, you probably inverted something. Also double-check any provided reliability factors – if the question is about 90% reliability, L_{10} is directly used. If it asked for median life (which is uncommon), you'd use a different factor (but again, not likely needed). By systematically breaking the problem into those steps – find loads, compute P, apply life formula – you can tackle bearing questions efficiently.

Topic 02 - Failure Theories and Analysis

Topic Introduction: Understanding failure theories is crucial for designing safe mechanical components and answering several questions on the **FE Mechanical Exam**. These theories predict when a material will **fail** (by fracture or yielding) under various states of stress. On exam day, you'll encounter questions like: "Given a set of stresses, will this brittle shaft crack?" or "Does this ductile part yield under combined loading?" By mastering failure criteria for brittle and ductile materials (and how to handle fatigue under cyclic loads), you'll know exactly which formula or criterion to apply. This topic matters because it ties directly to **factor of safety** decisions – picking the right theory ensures you neither over-design nor under-design a component. In our NAEX community sessions, we see that once you break these theories down, they're very logical – and with practice, you'll apply them with confidence. Let's turn these abstract theories into something you can **recognize instantly** and use effectively on the exam.

K14.T02.S01 – Static Failure Theories for Brittle Materials (Max Normal Stress & Mohr's Theory)

Principle Introduction: When dealing with **brittle materials** (like cast iron or glass), we assume they **fracture** rather than yield when overloaded. Key points to build intuition:

- **Brittle fracture criterion:** Brittle materials lack significant plastic deformation, so failure is expected when the *maximum tensile or compressive stress* reaches the material's strength limit. In practice, that means checking principal stresses against ultimate tensile strength (for tension) or ultimate compressive strength (for compression).
- **Maximum Normal Stress Theory (Rankine's criterion):** This simple theory says failure occurs when **any one** of the principal stresses equals the material's strength. In other words, a brittle element breaks if the largest principal stress σ_1 exceeds S_{ut} (ultimate tensile strength) or if the smallest principal stress σ_3 (most negative, i.e. largest compressive stress) goes below $-S_{\mathrm{uc}}$ (ultimate compressive strength).
- **Mohr's Theory (Coulomb-Mohr criterion):** This theory refines the prediction by considering *combined* states of stress. It uses Mohr's circles for the material's tensile and compressive strengths to form an **envelope of safe stress**. If the stress state's Mohr circle touches or exceeds that envelope, the brittle material fails. Coulomb-Mohr accounts for the fact that a combination of moderate tension and compression can cause fracture even if neither alone reaches its strength limit.
- **Tension vs. Compression Strength:** Brittle materials often have different strength in tension vs. compression (S_{ut} vs S_{uc}). Typically, S_{uc} is higher (material is stronger in compression). The Mohr envelope is not symmetric about the origin; it stretches further on the compressive side.
- **Application:** On the FE Exam, if a question involves a brittle material (e.g. a ceramic or cast metal) under static loads, you'll likely use one of these criteria. Often you'll check principal stresses: "Is any principal stress $\geq S_{\mathrm{ut}}$ or $\leq -S_{\mathrm{uc}}$?" If yes, the material is at failure (factor of safety = 1 in that case). If the problem hints at combined tension/compression, Coulomb-Mohr might be implied.

Exam Handbook Search Cues (Not affiliated with or endorsed by NCEES): *"maximum normal stress", "Coulomb-Mohr", "brittle fracture theory"*. (Use these keywords in the exam handbook to quickly find the reference formulas for brittle failure criteria.)

Footnotes:

- *Units:* Strengths S_{ut}, S_{uc} are typically given in **MPa** (SI) or **psi** (USCS). Stresses σ should be in the same units when comparing to strength. Always double-check unit consistency – the exam might mix unit systems as a trap.
- *Sign Convention:* By convention, tensile stress is positive and compressive is negative. That's why we check $\sigma_3 \leq -S_{\mathrm{uc}}$ (meaning $|\sigma_3| \geq S_{\mathrm{uc}}$ in compression). Watch the signs – confusing tension vs. compression has tripped up many students.
- *Scope:* "Static" here means a steady load (no fatigue involved). Brittle failure theories assume no significant yielding precedes fracture (valid for brittle materials only – **don't** apply these to ductile metals).

Equation Passport – Maximum Normal Stress (Rankine's) Criterion

- **Name & Purpose:** *Maximum Normal Stress Criterion* – predicts brittle failure by comparing principal stresses to material strength. Use this to decide if a brittle component will crack under given principal stresses.

- **Equation (failure occurs when):** $\max(\sigma_1, \sigma_2, \sigma_3) \geq S_{\mathrm{ut}}$ or $\min(\sigma_1, \sigma_2, \sigma_3) \leq -S_{\mathrm{uc}}$,
where $\sigma_1 \geq \sigma_2 \geq \sigma_3$ are the principal stresses. This is equivalent to saying $\sigma_1 \geq S_{\mathrm{ut}}$ (tensile failure) or $\sigma_3 \leq -S_{\mathrm{uc}}$ (compressive failure).

- **Variables and Units:**
- $\sigma_1, \sigma_2, \sigma_3$ – Principal stresses in the material (Pa or psi). σ_1 is the most tensile (or least compressive), σ_3 the most compressive.
- S_{ut} – Ultimate tensile strength of the material (Pa or psi).
- S_{uc} – Ultimate compressive strength (Pa or psi, typically given as a positive value for the magnitude).

- **Assumptions & Scope:**
- Material is **brittle** (little to no yield before break). Use the material's *ultimate* strengths. (For ductile materials, use yield strength with other criteria – see next subtopic.)
- No safety factor included in this form – it's the borderline of failure (FS = 1). For design safety, you'd ensure $\max(\sigma_i)$ is well below S_{ut} by a chosen factor of safety.
- Valid for static (steady) loading. Under fatigue/cyclic loads, use fatigue criteria instead.
- Principle applies in any loading scenario as long as you can find principal stresses (2D or 3D stress states). Typically, exam problems give either principal stresses directly or enough info to compute them (e.g. stress transformation formulas).

- **Limit Tests (Sanity Checks):**

- **All principal stresses zero:** Clearly safe (0 is nowhere near a strength limit).

- **One large tensile stress, others small:** If σ_1 hits S_{ut}, the criterion flags failure (makes sense: one big tensile stress can break a brittle material even if others are low).

- **Pure compression case:** If σ_3 (most negative) equals $-S_{\text{uc}}$, criterion flags failure. If compressive strength is larger in magnitude, pure compression might reach a much higher stress before failing – reflect on the material (e.g. cast iron can take more compression than tension).

- **Use vs. Sibling Criteria:** Use **Rankine's criterion** for a *quick, conservative check* of brittle failure. Use **Coulomb-Mohr** when a combination of tensile and compressive stresses is present and you want a more accurate (less conservative) prediction of brittle fracture. Rankine ignores the interplay between different stress components, whereas Coulomb-Mohr accounts for it. If a problem gives both tension and compression on a brittle material, Coulomb-Mohr is the better choice for exam accuracy.

- **Common Exam Traps:**

- **Using yield strength by mistake:** Remember, brittle materials don't have a meaningful yield; always use ultimate strength. An exam question might hand you both S_y and S_{ut} – pick S_{ut} for brittle fracture.

- **Confusing compressive strength:** Some students plug compressive strength as a negative number. Keep the magnitudes straight: if σ_3 is negative and large in magnitude, compare $|\sigma_3|$ to S_{uc}. The inequality $\sigma_3 \leq -S_{\text{uc}}$ already handles the sign.

- **Missing the worst-case principal stress:** The problem might give you stresses in x, y, z directions, but the largest principal stress might not just be one of those if shear is present. However, for exam simplicity, many brittle failure questions stick to cases where the given normal stresses are the principal stresses (shear = 0 or negligible). If shear is involved, you'd need to compute principal stresses (e.g. via Mohr's circle) before applying the criterion. Don't worry – the exam handbook provides transformation formulas if needed, or the question will simplify it for you.

Equation Passport – Coulomb-Mohr (Brittle Fracture) Criterion

- **Name & Purpose:** *Coulomb-Mohr Criterion* – predicts brittle failure by considering combined stress states, using an envelope based on both tensile and compressive strength tests. Use this when a brittle material is subjected to a mix of tension and compression; it refines failure prediction beyond the max stress alone.

- **Equation (failure envelope):** For a principal stress state with

$$\sigma_1 \geq \sigma_2 \geq \sigma_3$$

$$\text{if } \sigma_3 < 0 \text{ (one principal is compressive), then failure if}$$

$$\frac{\sigma_1}{S_{\text{ut}}} - \frac{\sigma_3}{S_{\text{uc}}} \geq 1\,.$$

This linear relation between σ_1 and σ_3 defines the boundary when one is tensile and the other compressive. If both principal stresses are tensile (or zero), this reduces to $\sigma_1 \geq S_{\text{ut}}$. If both are compressive (no tension at all), it reduces to $|\sigma_3| \geq S_{\text{uc}}$.

- **Variables and Units:**
- σ_1, σ_3 – Principal stresses (Pa or psi). Here we explicitly consider the case σ_1 positive (tension) and σ_3 negative (compression).
- $S_{\text{ut}}, S_{\text{uc}}$ – Ultimate tensile and compressive strengths (same units as σ).

- **Assumptions & Scope:**
- Material is brittle, with distinct tensile/compressive strengths. This criterion is essentially a piecewise linear *failure envelope* connecting $(\sigma_1 = S_{\text{ut}}, \sigma_3 = 0)$ and $(\sigma_1 = 0, \sigma_3 = -S_{\text{uc}})$ in principal stress space.
- Applicable when σ_1 is tensile and σ_3 compressive. For other stress sign combinations: use the appropriate segment of the envelope (all tension or all compression revert to the simpler checks).
- No factor of safety in the formula as written (FS = 1 boundary). Incorporate safety factors separately if required (e.g. demand $\frac{\sigma_1}{S_{\text{ut}}} - \frac{\sigma_3}{S_{\text{uc}}} \leq \frac{1}{n}$ for design with FS = n).

- **Limit Tests:**

- **Pure tension ($\sigma_3 = 0$):** The formula gives $\sigma_1/S_{\text{ut}} \geq 1$, i.e. $\sigma_1 \geq S_{\text{ut}}$ – matches the basic tensile failure condition.

- **Pure compression ($\sigma_1 = 0$, σ_3 negative):** It gives $-\sigma_3/S_{\text{uc}} \geq 1$, i.e. $|\sigma_3| \geq S_{\text{uc}}$ – the basic compressive failure condition.

- **Symmetric strengths ($S_{\text{ut}} = S_{\text{uc}}$):** The envelope becomes $\sigma_1 - \sigma_3 \geq S_{\text{ut}}$. If tensile and compressive strengths were equal (like an ideal brittle material), Coulomb-Mohr simplifies to a criterion that $\sigma_1 - \sigma_3$ (difference between max tension and max compression) exceeding the common strength causes failure.

- **One side extreme:** If σ_3 is very large in magnitude (deep compression) while σ_1 is modest, the formula might predict failure even if neither stress alone exceeds its strength. This reflects real behavior: a combination of tension and compression can activate fracture planes.

- **Use vs. Sibling Equations:** Use **Coulomb-Mohr** instead of the simple max-stress theory when *both tension and compression* act on a brittle part. It's more accurate in such mixed cases. The maximum-normal-stress (Rankine) criterion would be too lenient in predicting failure for combined loads – Coulomb-Mohr will often predict failure sooner (except in the pure tension or pure compression limits where they agree). Remember, **Coulomb-Mohr is for brittle materials only**; for ductile combined stresses, turn to von Mises or Tresca (next subtopic).

- **Common Exam Traps:**

- **Not recognizing a mixed stress state:** If an exam question gives one positive and one negative principal stress (e.g. $\sigma_1 = +200$ MPa, $\sigma_3 = -100$ MPa for a cast iron), that's your clue to apply Coulomb-Mohr. Using only $\sigma_1 < S_{\text{ut}}$ might wrongly conclude "safe" while Coulomb-Mohr shows failure.

- **Using wrong strength in the formula:** Keep S_{ut} with the tensile stress term and S_{uc} with the compressive term. If you accidentally swap them or use yield strength here, the result will be nonsense.

- **Neglecting units or mixing unit systems:** The linear combination $\frac{\sigma_1}{S_{\text{ut}}} - \frac{\sigma_3}{S_{\text{uc}}}$ assumes both numerator and denominator terms use consistent units. If σ is in MPa, S_{ut} and S_{uc} must be in MPa as well. Convert if necessary before plugging numbers.

- **Envelope vs. actual Mohr's circle:** The theory description refers to Mohr's circles and an envelope (as in the diagram above). For calculations, you usually won't need to sketch the circles on the exam – you can just use the formula form. However, visualizing it can help you avoid mistakes: e.g., knowing that a higher compression strength skews the envelope and allows more compression without failure.

- **Calculator Tip:** The formula $\frac{\sigma_1}{S_{\text{ut}}} - \frac{\sigma_3}{S_{\text{uc}}} = 1$ is straightforward to solve for one stress if you know the other. If solving for σ_1, rearrange to $\sigma_1 = S_{\text{ut}}(1 + \frac{\sigma_3}{S_{\text{uc}}})$ (taking care to input σ_3 as a negative number for compression). That's easy to compute on any FE-approved calculator – just be mindful of the sign on σ_3 when adding inside the parentheses.

Explanation & Analysis (Brittle Failure Theories): For brittle materials on the FE Exam, your decision tree is: (1) Are we dealing with a **uniaxial** stress case (force or bending in one direction)? If yes, use the maximum normal stress theory – basically just compare stress to strength. (2) Are there **multi-axial stresses** with both tensile and compressive components? If yes, Coulomb-Mohr is likely needed. The idea behind these is straightforward: brittle stuff breaks when stressed too much. Rankine's criterion is essentially "don't exceed what the material can take in tension or compression." Coulomb-Mohr says "even a moderate tensile stress can cause failure if there's also a compressive stress, because the combination creates a critical shear plane." In fact, Mohr's theory is like checking an inclined plane in the material where the resolved normal and shear stresses reach a critical combo.

Term by term, the Rankine criterion's terms σ_1 and σ_3 each get compared to a strength: σ_1 vs S_{ut}, σ_3 vs $-S_{\text{uc}}$. No cross terms – it's very direct. In Coulomb-Mohr's combined formula, $\frac{\sigma_1}{S_{\text{ut}}} - \frac{\sigma_3}{S_{\text{uc}}}$, if σ_3 is zero (no compression), it's just σ_1/S_{ut}. If σ_1 is zero (no tension), it becomes $-\sigma_3/S_{\text{uc}}$. In between, say σ_1 is half of S_{ut} and σ_3 is half of $-S_{\text{uc}}$, then $\frac{\sigma_1}{S_{\text{ut}}} - \frac{\sigma_3}{S_{\text{uc}}} = 0.5 - (-0.5) = 1.0$, meaning the combined effect reaches failure even though each stress alone was at only 50% of its respective strength. This linear interaction is a big takeaway: *a moderate tension plus a moderate compression can fracture a brittle material*. This is because brittle fracture is governed by **Mohr's circle reaching the material's internal fracture envelope** – basically, certain planes inside the material feel a combination of normal and shear stress that hits the critical condition for cracks.

On exam day, you typically won't derive any of this – you'll just plug numbers into whichever criterion fits. But knowing *why* helps you remember *which* to use. If you ever get stuck, remember: **brittle = compare to ultimate strength(s)**. And if two different kinds of stress are involved, think of Mohr's circle – that nudge might remind you to use the Coulomb-Mohr formula.

K14.T02.S02 – Static Failure Theories for Ductile Materials (Tresca & Von Mises Yield Criteria)

Principle Introduction: Ductile materials (like steel or aluminum alloys) generally **yield (deform plastically)** before breaking. For design, the onset of yield is usually the failure criterion, since a yielding part often means the end of safe operation. The FE Exam expects you to know two major theories for ductile yield under multiaxial stress: **Maximum Shear Stress Theory (Tresca)** and **Distortion Energy Theory (von Mises)**. Key points to remember:

- **Yield vs. Ultimate:** For ductile metals, use the **yield strength (S_y)** in failure criteria, not the ultimate tensile strength, because design is based on avoiding permanent deformation. (The exam may provide both S_y and S_{ut} for a ductile material – pick S_y for these criteria unless the problem specifically asks about failure at ultimate load.)
- **Maximum Shear Stress Theory (Tresca):** Tresca's (maximum shear stress) criterion says that yielding starts when the material's maximum shear stress reaches the same value that produces yield in a uniaxial tensile test. Equivalently, it predicts yield when the spread between the largest and smallest principal stresses satisfies $\sigma_1 - \sigma_3 = S_y$ (because the maximum shear stress is $(\sigma_1 - \sigma_3)/2$). It's a straight-line (hexagonal) yield surface in principal stress space – simple but slightly conservative.
- **Distortion Energy Theory (von Mises):** This theory states that yielding begins when the distortion (shear) strain energy in a general stress state reaches the same level as it does at yield in a simple tension test. It is applied using an equivalent (von Mises) stress, calculated from a combination of the three principal stresses. Von Mises gives a more accurate yield prediction for many ductile materials (it corresponds to a circular or elliptical yield surface in shear-dominated planes).
- **When to use which:** The FE Handbook provides both criteria. If the problem specifically names one (e.g. "using the maximum shear stress theory…") then use Tresca. If not specified, von Mises (distortion energy) is often a safe default for ductile materials unless simplicity of Tresca is needed. Some exam problems might indirectly hint at one ("compute the factor of safety according to the distortion-energy theory" or "maximum shear stress theory").
- **Combined vs. simple loading:** Under simple uniaxial tension, both theories agree (yield at $\sigma = S_y$). Differences arise in multiaxial stress: Tresca might predict yield a bit earlier (it's more conservative, especially for certain combinations like pure shear), whereas von Mises allows slightly more stress before yield for those combinations. Knowing the difference isn't usually tested quantitatively beyond recognizing which criterion is more conservative for a given scenario. But do recall: Tresca is easier to compute (max difference/2), von Mises is a quadratic combo.
- **FE Exam context:** Typical question: given principal stresses or stress components on a ductile metal part, determine if it yields by Tresca or von Mises, or compute the factor of safety. Another scenario: they might ask which theory corresponds to which formula. So memorize the form of each criterion's formula and what each symbol means.

Exam Handbook Search Cues (Not affiliated with or endorsed by NCEES): *"maximum shear stress theory", "Tresca yield", "distortion energy theory", "von Mises stress"*. (These terms will point you to the yield criteria equations in the exam reference.)

Footnotes:

- *Notation:* $\tau_{\max}$ denotes maximum shear stress. Be careful: sometimes $\tau_{\max}$ is called $\tau_{\max}$ or just written in terms of principal stresses as $(\sigma_1 - \sigma_3)/2$. σ_v or σ_e typically denotes the von Mises equivalent stress (the terms "effective stress" or "von Mises stress" mean the same thing).
- *Units:* As always, use consistent units. If S_y is given in MPa, your stresses should be in MPa. The von Mises formula involves squares of stresses – but since everything is in terms of ratios or comparisons to S_{y^2}, units will cancel out properly as long as you're consistent.
- *Shear yield in data:* Occasionally, a problem might give a "shear yield strength" for a material (like S_{sy}). Note that for ductile materials, S_{sy} is often about $0.5S_y$ (because in pure shear test, yield occurs at about half the tensile yield stress). Tresca basically uses this fact directly. The exam typically just gives S_y and expects you to infer shear yield as $S_y/2$ if needed, rather than directly providing S_{sy}.
- *Scope:* These criteria apply to static, ductile yielding problems. If the problem instead involves **fatigue** (repeated cycles), skip ahead – fatigue uses a different approach (coming up in subtopic K14.T02.S03).
- *Geometry note:* Principal stresses $\sigma_1, \sigma_2, \sigma_3$ are easiest to use in these formulas. If you're given stresses in x, y, z directions and perhaps shear, it might be easier to compute the von Mises stress using the formula with $\sigma_x, \sigma_y, \tau_{xy}$ (provided in the handbook for plane stress). But if all three principal stresses are provided (or easily found), plug them in directly.

Equation Passport – Tresca Yield Criterion (Max Shear Stress Theory)

- **Name & Purpose:** *Maximum Shear Stress Theory (Tresca)* – determines yielding based on shear. It answers the question: "Has the shear stress in this part reached a level that would cause yield in a tensile test specimen?" Use Tresca to evaluate yield for ductile materials, especially when looking for a quick, conservative check.

- **Equation (yield occurs when):** $\tau_{\max} = \frac{\sigma_1 - \sigma_3}{2} \geq \frac{S_y}{2}$.
Here $\tau_{\max}$ is the maximum shear stress in the material, and $S_y/2$ is the shear stress at yield as inferred from a uniaxial test. This can be rearranged to a more common form: $\sigma_1 - \sigma_3 \geq S_y$ (since $\sigma_1 - \sigma_3 = 2\tau_{\max}$). For a general 3D stress state, Tresca can be stated as: yield if *any* difference between two principal stresses $\geq S_y$. (If $\sigma_1 \geq \sigma_2 \geq \sigma_3$, then the critical difference is $\sigma_1 - \sigma_3$.)

- **Variables and Units:**
- $\tau_{\max}$ – Maximum shear stress in the material (Pa or psi). In terms of principal stresses, $\tau_{\max} = (\sigma_1 - \sigma_3)/2$ when $\sigma_1 \geq \sigma_3$.
- σ_1, σ_3 – Largest and smallest principal stresses (Pa or psi). (If all three principal stresses are equal, $\tau_{\max} = 0$ – trivial case of hydrostatic stress which causes no yield according to both Tresca and von Mises.)
- S_y – Yield strength of the material (Pa or psi). Use the yield strength in tension (which equals yield in compression for ductile metals, approximately).

- **Assumptions & Scope:**
- Material is homogeneous and ductile, yielding in shear as it would in a standard tensile test. Tresca assumes yield begins when the *shear* in the material equals that in the test that produced yield.
- Criterion is based on **pure shear equivalence**: yielding in torsion of a solid shaft occurs at $\tau = S_y/2$. Tresca extends that idea to any stress state.
- This theory does **not account for the intermediate principal stress** σ_2 (it only cares about the max and min). This makes it conservative; there are cases where von Mises predicts yield a bit later by considering the relieving effect of the middle stress.
- No factor of safety included in the basic inequality. For design, one would ensure $\sigma_1 - \sigma_3$ stays below S_y/n (introducing a safety factor n).

- **Limit Tests:**

- **Uniaxial tension:** If $\sigma_1 = \sigma_{\text{applied}}$, $\sigma_2 = \sigma_3 = 0$, then $\sigma_1 - \sigma_3 = \sigma_{\text{applied}}$. Yield predicted when $\sigma_{\text{applied}} \geq S_y$. Good – it matches reality (the part yields at its yield strength).
- **Pure shear:** If a shaft is in pure torsion, principal stresses are $\pm\tau$ (shear stress on 45° planes shows up as equal magnitude tension and compression). So $\sigma_1 = \tau, \sigma_3 = -\tau$. Then $\sigma_1 - \sigma_3 = 2\tau$. Tresca says yield when $2\tau \geq S_y$, i.e. $\tau \geq S_y/2$. So yield in shear occurs at half the tensile yield strength – again matching known material behavior (and likely given in the exam handbook as a reference point).

- **Equal biaxial tension:** If $\sigma_1 = \sigma_2 = \sigma_{\text{applied}}$ and $\sigma_3 = 0$ (like a plate under equal pull in two directions), then $\tau_{\max} = (\sigma_1 - \sigma_3)/2 = \sigma_{\text{applied}}/2$. Tresca yields when $\sigma_{\text{applied}}/2 \geq S_y/2$, i.e. $\sigma_{\text{applied}} \geq S_y$. So it predicts yield at the same S_y in equal-biaxial tension. (Von Mises in this case would allow a bit more, about 15% higher than S_y, so Tresca is conservative here.)

- **Use vs. Sibling Equation:** Use **Tresca** if asked for *maximum shear stress theory* specifically, or if you want a simpler check that errs on the safe side. Use **von Mises** (distortion energy) for a more accurate assessment when required. In terms of exam strategy: if not told which to use, von Mises is often assumed (because it's widely used in practice), but if you're doing a quick mental check, Tresca's $\sigma_1 - \sigma_3$ is faster to compute and gives a safe answer. It's also useful if the problem gives you $\tau_{\max}$ directly from Mohr's circle – then you can directly compare $\tau_{\max}$ to $S_y/2$.

- **Common Exam Traps:**

- **Using the wrong σ values:** Ensure you identify σ_1 and σ_3 correctly. If only two principal stresses are nonzero (common for plane stress cases), then yes, use those. But if three are given, don't accidentally use σ_2 (middle) in place of σ_3 or so. Sort them: largest minus smallest is what matters.

- **Forgetting factor of safety:** If the question asks for factor of safety using Tresca, you might set up $\frac{S_y}{\sigma_1 - \sigma_3}$ (if $\sigma_1 > \sigma_3 \geq 0$ for example). It's easy to invert by mistake or use half factors incorrectly. A reliable way: find $\sigma_1 - \sigma_3$ from the given loads, double it if you have $\tau_{\max}$ given, then compare to S_y. If $(\sigma_1 - \sigma_3)$ is, say, 200 MPa and S_y is 250 MPa, then FS = $S_y/(\sigma_1 - \sigma_3) = 1.25$. If the exam allowed calculator confuses you with fractions, just cross-multiply mentally: "I need $\sigma_1 - \sigma_3$ times FS to equal S_y" – that might guide you.

- **Mixing up Tresca and von Mises conditions:** A very common mix-up is thinking Tresca is the one with the square root formula and von Mises is the one with half the difference. It's actually the opposite: Tresca → difference (linear), von Mises → sqrt (quadratic). One way to remember: "Tresca" has 6 letters, "linear" has 6 letters (not a strong mnemonic, but maybe helps), or recall that Tresca's yield surface is a *hexagon* (flat sides – linear conditions), whereas von Mises is an *ellipse/circle* (curved – involves squares).

- **Shear vs. normal criteria confusion:** Some students see "shear stress theory" and panic looking for shear stress values. If the problem only gives normal stresses, don't panic – you compute $\tau_{\max}$ from those (half the difference of principals). Conversely, if given shear, you might need to derive principals. Tresca connects these worlds: normal stress differences produce shear. Recognize the connection.

Equation Passport – von Mises Yield Criterion (Distortion Energy Theory)

- **Name & Purpose:** *Distortion Energy Theory (von Mises Criterion)* – predicts yielding by the combined distortion energy in the material. Use this to evaluate ductile yield in complex loading when you want the **standard industrial criterion**; it's the most commonly used yield theory for ductile materials due to its accuracy in many cases. On the exam, if asked for "von Mises stress" or "distortion energy," this is the one.

- **Equation (yield occurs when):**

$$\sigma_{\mathrm{v}} = \sqrt{\frac{(\sigma_1-\sigma_2)^2+(\sigma_2-\sigma_3)^2+(\sigma_1-\sigma_3)^2}{2}} \geq S_y$$

This formula defines the **von Mises equivalent stress** σ_{v}. Yielding begins when σ_{v} reaches the yield strength S_y. In a simpler (perhaps more memorable) form for plane stress (two principal stresses σ_A, σ_B and $\sigma_3 = 0$), the formula reduces to: $\sigma_{\mathrm{v}} = \sqrt{\sigma_{A^2} - \sigma_A\sigma_B + \sigma_{B^2}}$, which is equivalent to the full form but assumes the third stress is zero. Another common form in terms of stress components: $\sigma_{\mathrm{v}} = \sqrt{\sigma_{x^2} + \sigma_{y^2} - \sigma_x\sigma_y + 3\tau_{xy}^2}$, for an element in plane stress. All are the same criterion expressed differently.

- **Variables and Units:**
- σ_{v} – Von Mises equivalent stress (Pa or psi). This is a computed value that represents an "effective" single stress that has the same distortion energy as the actual combined stress state.
- $\sigma_1, \sigma_2, \sigma_3$ – Principal stresses (Pa or psi). They can be in any order in the formula due to the squares; just use all three (taking zero for any missing third component in 2D cases).
- $\sigma_x, \sigma_y, \tau_{xy}$ – Stress components in orthogonal directions (Pa or psi). Use these if principal stresses are not directly given. The formula shown is for plane stress (no σ_z term; if out-of-plane exists, one would include similar terms).
- S_y – Yield strength (Pa or psi). The right side of the inequality is S_y for onset of yield.

- **Assumptions & Scope:**
- Material is ductile and isotropic, and yielding is governed by distortion energy (the energy of shape change, not volume change). Von Mises ignores hydrostatic pressure – meaning if all three principal stresses are equal (a pure hydrostatic state), σ_{v} comes out zero and no yield is predicted, which aligns with reality (a block under high pressure might not yield because it's just being squeezed uniformly with no shape distortion).
- It's an empirical theory that works well for metals. In fact, many real test data confirm von Mises as a good predictor for yield initiation in ductile steels, etc.
- It accounts for all three principal stresses (unlike Tresca which simplifies to two extremes). This makes it **more accurate but a bit more complex** computationally.
- No safety factor included in formula; incorporate factor n by requiring $\sigma_{\mathrm{v}} \leq S_y/n$ if designing with a margin.

- **Limit Tests:**

- **Uniaxial tension:** Suppose $\sigma_1 = \sigma_{\text{applied}}, \sigma_{2,3} = 0$. Then $\sigma_{\mathrm{v}} = \sqrt{\frac{(\sigma_{\text{applied}}-0)^2+(0-0)^2+(\sigma_{\text{applied}}-0)^2}{2}} = \sqrt{\frac{2\sigma_{\text{applied}}^2}{2}} = |\sigma_{\text{applied}}|$. So yield when $|\sigma_{\text{applied}}| = S_y$. Matches reality, good. (Plus, it shows von Mises doesn't care if that one stress is tensile or compressive; yield is at the same magnitude S_y in either direction for ductile materials, which is typically true as S_y in tension $\approx S_y$ in compression.)

- **Pure shear:** $\sigma_1 = \tau, \sigma_2 = 0, \sigma_3 = -\tau$ (principal stresses for pure shear, like torsion). Then

$$\sigma_{\mathrm{v}} = \sqrt{\frac{(\tau-0)^2+(0-(-\tau))^2+(\tau-(-\tau))^2}{2}}$$

$$= \sqrt{\frac{\tau^2+\tau^2+(2\tau)^2}{2}} = \sqrt{\frac{5\tau^2}{2}} = \tau\sqrt{2.5} \approx 1.581\tau$$

Setting $\sigma_{\mathrm{v}} = S_y$ gives $\tau \approx 0.577S_y$. So von Mises predicts yield in pure shear at $\tau \approx 0.577S_y$ (57.7% of tensile yield). Compare with Tresca's $\tau = 0.5S_y$. Von Mises allows ~15% higher shear stress before yield, reflecting its less conservative nature.

- **Equal biaxial tension:** $\sigma_1 = \sigma_2 = \sigma, \sigma_3 = 0$. Then $\sigma_{\mathrm{v}} = \sqrt{\sigma^2 - \sigma^2 + \sigma^2} = \sigma$. Yield when $\sigma = S_y$. Interestingly, for equal biaxial tension, von Mises gives the *same* result as uniaxial: yield at S_y. (Tresca in this case also gave yield at S_y; in fact for equal-biaxial both criteria coincide in result, though not in general shape of surface.)

- **One principal out of whack:** If one principal stress is much larger than the others, σ_{v} will be dominated by that large one (approx equal to it, since it appears in two of the three squared difference terms). If two are large and opposite sign (tension vs compression), von Mises effectively adds them in a root-sum-square way, which is less than linear sum – capturing that opposing stresses partly cancel in terms of distortion energy.

- **Use vs. Sibling Equation:** Use **von Mises** for a precise check of yield in ductile materials under complex loads, or whenever the problem says "distortion energy" or "von Mises stress." If the exam problem is theoretical (e.g. asking which theory gives a bigger/smaller safety factor for a given case), recall that **Tresca is more conservative** (predicts yield at lower combined stress) than von Mises. In design, von Mises is prevalent, but exam questions might test understanding by asking for both or comparing them. If they ask for "factor of safety according to von Mises," be sure to use the von Mises equivalent stress. If they ask "according to Tresca," use $\sigma_1 - \sigma_3$.

- **Common Exam Traps:**

- **Dropping the 1/2 factor or sqrt by mistake:** The von Mises formula is a bit heavy. A classic mistake is to forget the $1/2$under the square root or to forget to take the square root entirely. Writing the formula carefully helps. Also note that the formula as given already has the $1/2$; some sources define σ_v^2first and then equate $\sigma_v = S_y$. Just ensure you plug in values correctly; your calculator can handle it, but use parentheses liberally, e.g.

$$\sigma_v = \sqrt{\frac{(\sigma_1-\sigma_2)^2+(\sigma_2-\sigma_3)^2+(\sigma_1-\sigma_3)^2}{2}}$$

to be safe.

- **Using wrong stresses:** If a problem provides $\sigma_x, \sigma_y, \tau_{xy}$ for a 2D stress state, a mistake is to plug those directly into the 3D principal formula. Either compute principal stresses first *or* use the plane stress form directly. Remember that in plane stress $\sigma_3 = 0$. It might be quicker to just use

$$\sigma_v = \sqrt{\sigma_{x^2} + \sigma_{y^2} - \sigma_{x\sigma_y} + 3\tau_{xy}^2}$$

which is provided in the handbook. Many examinees who try to derive that on the fly may drop a term. So, make use of the provided form if you're not fully confident deriving it under pressure.

- **Confusing von Mises with principal averaging:** Von Mises is *not* just an average or simple sum of stresses; it's rooted in energy. For example, if someone erroneously took a straight average of stresses or something, they'd get it wrong. Stick to the formula. If you absolutely forget it, know that σ_v lies somewhere between the largest principal and the range $\sigma_1 - \sigma_3$ (closer to σ_1 usually). But best is to recall the formula or find it quickly in the handbook by searching "distortion energy."

- **Sign handling:** Good news: in the von Mises formula, signs of the principal stresses don't matter because everything is squared. If you're plugging σ_x, σ_y, τ_{xy}, just be careful to square τ_{xy} (include the factor 3) and include the minus sign in $\sigma_{x\sigma_y}$ (since if one is negative, the product term becomes negative *times* negative = positive, which naturally happens when you input the values). Essentially, trust the formula – don't override it with your intuition about tension/compression directions, because von Mises already handled that by disregarding pure hydrostatic parts.

- **Units in calculation:** Because you square stresses, sometimes students mix units inadvertently (e.g., one stress in MPa, another in Pa). This is disastrous since you'll be adding apples and oranges squared. Always convert all stresses to the same unit set first. A quick consistency check: if using MPa, your σ_v will come out in MPa; if mixing, you might get a nonsensical huge or tiny number. So keep it consistent.

Explanation & Analysis (Ductile Yield Theories): In essence, both Tresca and von Mises are ways to reduce a complicated multi-axial stress state to a single comparable number and check it against S_y. Tresca's number is $\sigma_1 - \sigma_3$ (twice the max shear). Von Mises' number is σ_v from that square root formula. Why two approaches? Historically, they come from different reasoning (shear vs energy), and experimentally von Mises often matches better, but Tresca is simpler.

On the FE Exam, you should be able to compute both if asked, but usually it'll be clear which one to use. **Think about the material and the phrasing.** If it's steel and they just ask "will it yield under these combined stresses," you could use von Mises unless directed otherwise. If they specifically mention "according to the maximum shear stress theory," that's your Tresca cue.

Let's break down von Mises' formula to understand each part physically: $(\sigma_1 - \sigma_2)^2 + (\sigma_2 - \sigma_3)^2 + (\sigma_1 - \sigma_3)^2$ – this is summing the squared differences of principal stresses. It essentially measures how far apart the stresses are from each other. If all three were equal (no differences), this sum is zero – meaning no distortion, just like a hydrostatic pressure causes no yield. If one stress is much bigger than the others, the differences will be large, increasing σ_v. The $\frac{1}{2}$ factor averages those differences a bit. After the square root, σ_v ends up with the same units as stress and can be directly compared to S_y.

Tresca's breakdown is simpler: it only cares about the largest gap between stresses. For example, if you have σ_1 tensile and σ_3 compressive, that gap might be huge – Tresca will flag yield once that gap equals S_y. Von Mises in that scenario would consider σ_2 too (if it's in between) and might be a bit more forgiving if σ_2 is helping by not being as far from the extremes.

In practice, if you calculated both for a given stress state, you'd find σ_v is always a bit smaller or equal to $(\sigma_1 - \sigma_3)$ (for non-negative σ_2 cases, etc.), meaning von Mises allows slightly higher loads before yield. For the exam, it's enough to apply whichever formula is asked for and compare to S_y. If the question asks for a factor of safety, you compute either $\frac{S_y}{\sigma_v}$ or $\frac{S_y}{(\sigma_1 - \sigma_3)}$ as appropriate (assuming those formulas gave the required yield condition = S_y).

Special Notes – Calculator Use: When using the von Mises formula on your calculator, pay close attention to parentheses. For example, on a TI-36X Pro, you might input:

$$\sqrt{\frac{(\sigma_1 - \sigma_2)^2 + (\sigma_2 - \sigma_3)^2 + (\sigma_1 - \sigma_3)^2}{2}}$$

Make sure to close the sqrt at the end and divide by 2 inside before the final parenthesis. It's easy to make a slip, so sometimes it's safer to calculate step by step: compute the three differences, square them, sum, divide by 2, then take sqrt. On the Casio fx-115/991, you could store differences in memory and recall to sum, etc., to reduce parenthesis chaos. Tresca's calculation is straightforward – just find the difference and maybe divide by 2 if you directly compare shear stress. Generally, double-check that you're comparing the right quantity to the right form of strength (e.g., if you computed $\tau_{\max}$, compare to $S_y/2$, but if you computed $\sigma_1 - \sigma_3$, compare to S_y). A quick mental check: von Mises result should lie somewhere between the largest principal stress and the largest principal difference; if your σ_v comes out higher than $\sigma_1 - \sigma_3$, you've likely made an input error.

K14.T02.S03 – Fatigue Failure Criteria under Combined Loading (Mean & Alternating Stress)

Topic Introduction: Not all failures happen under one-time static loads – many components fail after repeated **cyclic loading**, even if the stress is below the static strength. This is **fatigue failure**, a critical topic for mechanical design and for the FE Exam. Here we focus on combined loading fatigue criteria: how to handle a stress that has a **mean (steady) component and an alternating (fluctuating) component**. The exam often uses *Goodman* or *Gerber* diagrams/criteria to combine these stresses and check against material limits. Key points:

- **Mean vs Alternating Stress:** In fatigue, imagine stress in a part oscillating between a maximum and minimum. We define the *mean stress* $\sigma_m = (\sigma_{\max} + \sigma_{\min})/2$ and the *alternating stress* $\sigma_a = (\sigma_{\max} - \sigma_{\min})/2$. A purely reversing load (like tension to compression equally) has $\sigma_m = 0$ and σ_a equal to the amplitude. A mean stress that's not zero (like fluctuating between two tensile values) can significantly affect fatigue life – generally, a higher mean stress makes fatigue failure more likely even if the alternating part is the same.

- **Goodman Criterion (Modified Goodman Line):** This is a linear fatigue failure relationship between σ_a and σ_m. It basically draws a line from the endurance limit on the σ_a axis (when $\sigma_m = 0$) to the ultimate strength on the σ_m axis (when $\sigma_a = 0$). If the stress combination (σ_m, σ_a) lies above this line, failure occurs. Modified Goodman is widely used for design: it's conservative, using ultimate strength to account for mean stress effect.
- **Gerber Criterion:** This is a parabolic relationship between σ_a and σ_m (parabolic curve from $\sigma_a = S_e$ at $\sigma_m = 0$ down to $\sigma_a = 0$ at $\sigma_m = S_{ut}$). Gerber's parabola is a bit less conservative than Goodman's straight line for intermediate mean stresses. It fits experimental data for many ductile materials better than a straight line. However, because it can overestimate allowable stress near the ultimate strength, some engineers prefer the simpler Goodman line for design safety.
- **Soderberg Criterion:** Another linear criterion, even more conservative, from $\sigma_a = S_e$ at $\sigma_m = 0$ to $\sigma_a = 0$ at $\sigma_m = S_y$ (yield strength). Soderberg basically replaces ultimate strength with yield strength, shrinking the allowable region. It's a safe-but-often too conservative criterion; not as commonly used in practice but sometimes mentioned in textbooks.
- **How to use these:** The exam might present a fatigue problem like: "A rotating shaft experiences a fully reversed bending stress of X and a steady axial stress of Y; using the Goodman criterion, what is the factor of safety against fatigue?" You'd identify σ_a and σ_m, pick the right criterion (Goodman unless told otherwise), and plug into the equation to solve for factor of safety or check pass/fail.
- **Endurance Limit (S_e):** Note that all these criteria involve S_e (the endurance limit, or fatigue limit) on the alternating stress axis. We'll cover S_e in the next subtopic, but remember that S_e is basically the stress amplitude a material can endure indefinitely (for steel, typically around half the ultimate strength for rotating bending test specimens). If the material is not steel or doesn't have a clear endurance limit (like aluminum, which has no true endurance limit), the exam problem will likely give you a fatigue strength at a certain life or specify what to use for S_e.
- **Exam tip:** If you see mention of "mean stress" and "alternating stress" or a graph with a line or curve between S_e and S_{ut}, you're in Goodman/Gerber territory. Also, keywords like "fully reversed" (which means $\sigma_m = 0$) or "fluctuating with a mean stress" are hints. Know the basic equation forms and which points they connect.

Exam Handbook Search Cues (Not affiliated with or endorsed by NCEES): *"Goodman criterion", "Gerber fatigue", "mean stress", "alternating stress", "Soderberg"*. (The exam handbook lists Modified Goodman and Soderberg formulas; Gerber might not be explicitly given there, but it's fair game conceptually.)

Footnotes:

- *Notation:* S_e typically denotes the **endurance limit** (sometimes with a prime $S_e{}'$ for an unmodified laboratory value – more on that later). S_{ut} is the ultimate tensile strength, and S_y the yield strength. σ_a is alternating stress amplitude, σ_m is mean stress. These symbols are standard; make sure not to confuse σ_a with area or acceleration – here it's clear from context it's stress amplitude.
- *Units:* All stresses in these criteria should be in the same units (usually MPa in SI for exam, or maybe ksi in USCS if they give strengths in psi). The equations are dimensionless comparisons, so unit consistency is key. If you mix units (e.g., use MPa for one term and psi for another), you'll get a nonsense result.
- *Factors of Safety:* The handbook formulas often show versions "with a factor of safety" by including an n (factor of safety) in the denominators. For instance, $\frac{\sigma_a}{S_e} + \frac{\sigma_m}{S_{ut}} = \frac{1}{n}$ would be a design condition if you're solving for n. If no factor of safety is considered (just checking failure), it's $\frac{\sigma_a}{S_e} + \frac{\sigma_m}{S_{ut}} = 1$. The exam might give you n explicitly or ask you to find it.
- *Mean stress effect:* Intuitively, a tensile mean stress $\sigma_m > 0$ makes fatigue worse (allowable σ_a goes down), while a compressive mean stress ($\sigma_m < 0$) actually helps (it can increase fatigue life by "relieving" the alternating tension). The Goodman and Soderberg criteria are usually drawn for $\sigma_m \geq 0$ (conservative side; they often don't credit the benefit of compression). Gerber being a parabola is symmetric enough that a bit of compression just moves you left of the origin which isn't typically plotted – but in practice, compressive mean stress can be treated as negative σ_m which effectively increases the safety margin. If a problem includes a compressive mean, often you can just subtract it in computing σ_m (making σ_m smaller or negative, which is safer).
- *Scope:* These criteria assume **high-cycle fatigue** (typically $> 10^6$ cycles, where endurance limit concepts apply) and **fully reversed or alternating loading** where the material's response is within the elastic range each cycle. If the problem is about low-cycle fatigue or plastic strain cycles, that's a different regime (usually not in FE exam depth). Also, these are for normal stresses; if dealing with alternating shear, you'd analogously use shear endurance limits, but exam usually sticks to normal stress fatigue in straightforward ways.

Diagram Passport – Mean vs. Alternating Stress Criteria

- **Diagram Title & Role:** *Fatigue Failure Criteria (Goodman, Gerber, Soderberg)* – visualizes safe and unsafe regions for infinite-life fatigue under combined mean and alternating stress. This chart helps decide if a given stress amplitude and mean will cause fatigue failure.

- **Axes & Quantities:** Horizontal axis is **mean stress** σ_m, vertical axis is **alternating stress** σ_a. Units are typically MPa (or ksi) for both. σ_m increases to the right, σ_a increases upward. The plot is typically bounded by points related to material strengths: on the vertical axis, $\sigma_m = 0$, $\sigma_a = S_e$ (the endurance limit at zero mean). On the horizontal axis, $\sigma_a = 0$, $\sigma_m = S_{ut}$ (for Goodman/Gerber) or $\sigma_m = S_y$ (for Soderberg).

- **Key Regions & Thresholds:**

- The **Goodman line** is a straight line connecting $(\sigma_m = 0, \sigma_a = S_e)$ and $(\sigma_m = S_{ut}, \sigma_a = 0)$. Above this line (toward top-right) is failure, below (bottom-left) is safe (infinite life).
- The **Gerber curve** is a parabola connecting the same two points $(0, S_e)$ and $(S_{ut}, 0)$. It bows outward, meaning it allows a bit more σ_a for a given σ_m than Goodman (except at the endpoints which coincide).

- The **Soderberg line** connects $(0, S_e)$ to $(S_y, 0)$. This line lies entirely below the Goodman line because $S_y < S_{ut}$ for any material (except a hypothetical perfectly brittle one). So Soderberg's safe region is the most restrictive (smallest).

- Often the region below all these curves/lines is the design safe zone. If you're below Soderberg, you're definitely safe. Between

Soderberg and Goodman, you're safe by Goodman but with a smaller margin by Soderberg's stricter view. Between Goodman and Gerber, you're safe by Gerber but Goodman would flag failure (so it's a margin that Gerber allows).

- **How to Read It (Exam-style):** Given a specific σ_m and σ_a, you plot that point. If the point lies **below the chosen criterion line/curve**, it means $\frac{\sigma_a}{S_e}$ + (something with σ_m) was less than 1, so no failure – infinite life is expected. If the point lies **above the line**, that indicates failure (or finite life) – the stresses are too high for infinite life. Many exam problems won't actually ask you to plot, but rather to compute a safety factor. Essentially, computing a safety factor is like seeing how far below the line you are. For example, in Goodman:

$$FS = \frac{1}{\frac{\sigma_a}{S_e} + \frac{\sigma_m}{S_{ut}}}$$

which scales you down to the boundary.

- **Common Misreads:**

- Confusing which line is which: Remember, **Goodman = straight line to S_{ut}, Soderberg = straight line to S_y, Gerber = curve to S_{ut}**. If you only recall one, it's likely Goodman (commonly taught) – the exam might specify if they want Gerber. The presence of a yield strength usually hints at Soderberg usage.
- Misidentifying axes: Some might mistake the axes for max/min stress instead of mean/alternating. Mean is the average (steady component), alternating is the oscillating part. The diagram's x-axis intercept is S_{ut}, not S_y, unless it's specifically a Soderberg chart. Make sure to use the right ultimate or yield depending on criterion.

- Using the wrong endurance limit: If the problem gives you a modified endurance limit or asks you to calculate it (with factors from next subtopic), use the final S_e in these equations. If they just give a material's S_e outright, use that. Don't confuse S_e with S_{ut} or S_y – all three may appear in the formulas, so keep them straight (e.g., S_e usually much lower than S_{ut}).

- Linear vs. Parabolic: If asked for Gerber and you apply a linear Goodman equation, your answer will differ. Recognize key terms: "Gerber" implies you should use the parabolic formula $\frac{\sigma_a}{S_e} + (\frac{\sigma_m}{S_{ut}})^2 = 1$ (that's the equation of Gerber's parabola). If not given, you can derive it from the idea that it's a parabola through the same endpoints. For safety factor with Gerber: $(\frac{\sigma_a}{S_e} + (\frac{\sigma_m}{S_{ut}})^2) = \frac{1}{n}$ would be the relation.

Goodman, Gerber, and Soderberg criteria plotted for a steel with $S_{ut} = 600$ MPa, $S_y = 400$ MPa, and endurance limit $S_e = 300$ MPa. The blue line is Modified Goodman (straight line to S_{ut}), the red dashed line is Soderberg (to S_y), and the green dash-dot curve is Gerber's parabola. Any operating point (σ_m, σ_a) under these lines means infinite fatigue life. For example, at zero mean stress, the part can endure 300 MPa alternating (the endurance limit). With a mean stress of 200 MPa, Goodman's line would allow about 150 MPa alternating (point on blue line), while Gerber's curve allows a bit more (~170 MPa at that mean). Soderberg is most conservative, allowing only ~100 MPa alternating at 200 MPa mean. Typically, the exam will use the Modified Goodman line unless stated otherwise, balancing safety and material capacity.

Equation Passport – Modified Goodman Criterion
(This is the most commonly referenced fatigue criterion on the FE Mechanical Exam for combining mean and alternating stresses.)

- **Name & Purpose:** *Modified Goodman Equation* – provides a linear relationship to evaluate fatigue safety for a given mean and alternating stress. It helps you answer: "Given this steady stress and cyclic stress, will the part last indefinitely?" Use it for conservative fatigue design or assessment when an ultimate failure could happen due to the combination of stresses.

- **Equation (failure if ≥1):**

$$\frac{\sigma_a}{S_e} + \frac{\sigma_m}{S_{ut}} = 1$$

If the left-hand side exceeds 1, the stress point is above the Goodman line, meaning fatigue failure is expected. If it's below 1, the combination is safe for infinite life (in theory). With a factor of safety n, the design criterion is often written as $\frac{\sigma_a}{S_e} + \frac{\sigma_m}{S_{ut}} \leq \frac{1}{n}$, or equivalently $\frac{\sigma_a}{S_e/n} + \frac{\sigma_m}{S_{ut}/n} = 1$ in the handbook's form.

- **Variables and Units:**
- σ_a – Alternating stress amplitude (Pa or psi). For example, if stress cycles between 50 and 90 MPa, then $\sigma_a = (90 - 50)/2 = 20$ MPa.
- σ_m – Mean stress (Pa or psi). Using the same example, $\sigma_m = (90 + 50)/2 = 70$ MPa. Mean can be tensile (positive) or compressive (negative).
- S_e – Endurance limit (Pa or psi). This is the fully reversed ($\sigma_m = 0$) fatigue strength for infinite life. Use the **modified endurance limit** for the actual part (if given or calculated with factors). If the problem just says "endurance limit", assume that's the value to use, already accounting for any modifications unless instructed otherwise.
- S_{ut} – Ultimate tensile strength (Pa or psi). Use the same unit system as S_e and stresses. This represents the σ_m intercept of the Goodman line (no alternating component, fail at ultimate strength).
- n – factor of safety (dimensionless) if applying one. If solving for n, you might set up $\frac{\sigma_a}{S_e} + \frac{\sigma_m}{S_{ut}} = \frac{1}{n}$.

- **Assumptions & Scope:**
- Criterion assumes high-cycle fatigue (endurance limit applies) and that failure is fatigue-driven. If $\sigma_{\max}$ exceeds yield (S_y), then static yield would actually govern instead of fatigue – the Modified Goodman doesn't directly include yield, so separately ensure $\sigma_{\max} < S_y$ when using this for design (the exam might implicitly ensure that or mention check of $\sigma_{\max}$).
- Modified Goodman is an empirical linear fit – conservative especially at high mean stress. It implicitly assumes that a mean stress equal to S_{ut} with zero alternating will cause failure (which is true – that's just static failure). And at zero mean, $\sigma_a = S_e$ causes failure (by definition of S_e). Between, it linearly interpolates.
- Only applies when $\sigma_m \geq 0$ (tensile mean). If σ_m is negative (compressive mean), the equation would predict a negative second term which actually *reduces* the sum – meaning a compressive mean allows higher σ_a. In practice, designers often just use $\sigma_m = 0$ for compressive or set the term to zero, making it extra safe. But if a problem explicitly gives a compressive mean, you can plug it in with a negative sign, yielding a smaller LHS sum (indicating better fatigue life). The exam will likely focus on tensile or zero means to avoid confusion.

- **Limit Tests:**

- **Zero mean ($\sigma_m = 0$):** The equation gives $\sigma_a = S_e$. Good – that's exactly the definition of S_e. If your alternating stress is below S_e with no mean stress, infinite life is expected. If it equals or exceeds S_e, failure (eventually) by fatigue.
- **Zero alternating ($\sigma_a = 0$):** Then it gives $\sigma_m = S_{ut}$. That makes sense: if there's no fluctuation, the only way to "fail by fatigue" on the Goodman line is to just hit the static ultimate strength once (which is a static failure really, but it defines the boundary end). In reality, if $\sigma_a = 0$ and σ_m is just some steady stress, fatigue isn't an issue; but the Goodman line at $\sigma_m = S_{ut}$ is basically telling you the obvious static limit. The real utility is for $\sigma_a > 0$.
- **Mean equals half of S_{ut}:** Then the formula would allow σ_a up to half of S_e (because $\frac{\sigma_a}{S_e} + \frac{0.5S_{ut}}{S_{ut}} = \frac{\sigma_a}{S_e} + 0.5 = 1$, so $\frac{\sigma_a}{S_e} = 0.5$, $\sigma_a = 0.5S_e$). This shows how a moderate mean reduces the allowable alternating linearly.
- **Mean very large approaching S_{ut}:** Then σ_a must be very small to stay safe. If σ_m is, say, 90% of S_{ut}, then $\frac{\sigma_m}{S_{ut}} = 0.9$, leaving only 0.1 for σ_a/S_e. That means allowable $\sigma_a = 0.1S_e$ – quite small. In other words, a part under a high steady load has very little fatigue capacity for fluctuations.
- **Use vs. Variations:** Use **Modified Goodman** unless told otherwise for mean stress corrections. It's more conservative than Gerber, less than Soderberg – a reasonable middle. If a problem mentions Gerber, use the parabolic variation (which would replace that second term with $(\sigma_m/S_{ut})^2$ inside a square root or so). If it mentions Soderberg, use yield in place of S_{ut} for the second term. But Goodman is the go-to in most cases. If no criterion is specified on a fatigue mean stress problem, assume Modified Goodman (unless the context screams otherwise).

- **Common Exam Traps:**

- **Mis-identifying σ_a and σ_m:** The problem might give max and min stress values. Always calculate σ_m and σ_a correctly. For example, "fluctuates from 50 MPa to 90 MPa" → $\sigma_m = 70$ MPa, $\sigma_a = 20$ MPa. A mistake would be to take σ_a as 40 (difference, not half the difference) or as 90 (just using max). Also note if it says "fully reversed stress of 90 MPa", that means $\sigma_{\max} = +90$ MPa, $\sigma_{\min} = -90$ MPa, so $\sigma_m = 0$, $\sigma_a = 90$ MPa.
- **Plugging yield strength in wrong place:** Modified Goodman uses S_{ut} in the mean stress term. If you accidentally use S_y, you're doing Soderberg (which is a different, more conservative criterion). The exam might even test conceptual understanding by asking something like "which criterion replaces S_{ut} with S_y?" – answer: Soderberg. So keep that straight.
- **Forgetting to use modified S_e:** If the previous part of a problem had you calculate an endurance limit after applying factors (surface, size, etc.), *use that* S_e in the Goodman equation, not the original 0.5 S_{ut} or whatever. If you skip that, you'll overestimate fatigue strength.
- **Units confusion in formula:** Because you are adding two fractions, a lot of students think too hard about units here – just ensure $S_e, S_{ut}, \sigma_a, \sigma_m$ are all in the same units so that each fraction is dimensionless. The sum of two dimensionless quantities is dimensionless (and is set to 1 for failure). If you find yourself adding, say, 200 MPa / 300 MPa + 14,500 psi / 50,000 psi = ???, you've mixed units (since 14,500 psi ≠ 100 MPa, for instance). Convert one set. The exam usually sticks to one system within a single problem, but double-check the given units.
- **Mean stress beyond ultimate:** In reality, you can't have a stable mean stress above the ultimate strength – the part would have already broken from a static overload. The Goodman equation isn't meant to be used for $\sigma_m > S_{ut}$; if you plug that in, you get a nonsensical negative allowance for σ_a. If an exam scenario pushes near that, it's likely a trick to see if you note that static failure governs first. Generally, if σ_m is given above yield or ultimate, the part isn't going to survive regardless of σ_a. So remember, check static conditions too: **fatigue criteria assume you haven't already failed by yielding or fracture statically**.

Variations & Related Criteria:

- **Gerber's Equation (parabolic):** $\frac{\sigma_a}{S_e} + (\frac{\sigma_m}{S_{ut}})^2 = 1$. Use this if asked for Gerber. It gives a curved boundary (more forgiving for moderate σ_m). Calculation-wise, if solving for one of the stresses, it's a quadratic equation – be mindful of picking the realistic root. The exam might not require heavy math on this; often they'll stick to Goodman unless they want a conceptual comparison.
- **Soderberg's Equation (very conservative):** $\frac{\sigma_a}{S_e} + \frac{\sigma_m}{S_y} = 1$. This line is entirely inside Goodman's safe zone. Only use if explicitly told, or if doing a quick rough estimate for a high-safety requirement. On the exam, if they mention Soderberg, it's likely either to see if you know it uses S_y, or in a multiple-choice theory question. Numerical usage is straightforward like Goodman, just smaller allowable values.
- **ASME Elliptic (not in FE Handbook likely):** Sometimes referenced in textbooks – an ellipse between S_e and S_y. Not commonly tested on FE, but just know there are other criteria. FE sticks to the big three above.
- $\sigma_{\max} < S_y$ **Check:** As mentioned, always ensure the maximum stress $\sigma_{\max} = \sigma_m + \sigma_a$ does not exceed yield. If it does, yield happens before fatigue matters. The Modified Goodman relation doesn't explicitly include this check, but good engineering practice does. The exam might implicitly assume it or might ask separately about yielding. For instance, a question might ask "Is the shaft safe in infinite fatigue life, and is yielding a concern?" – then you'd check both Goodman and compare $\sigma_{\max}$ to S_y.

Explanation & Analysis: To solve combined loading fatigue problems, follow these **steps** (this is how I coach students in our study groups to avoid mistakes):

1. **Identify σ_a and σ_m:**
   Read the problem and determine the stress range. If given max/min stresses, compute mean and alternating. If given amplitude and mean directly, even better. Remember fully reversed means $\sigma_m = 0$.
   Be careful if multiple load types contribute (like bending plus axial). Often the exam simplifies it so that one type provides the alternating part (like bending causing a cyclic stress as the shaft rotates) and another provides a steady part (like a constant axial load). In such cases, superimpose them at critical location: add the steady stress to the mean, the alternating to σ_a.

2. **Pick the criterion:**

   If not stated, go Modified Goodman (safe choice). If the problem explicitly says Gerber or Soderberg, or hints (like giving a parabolic equation or referencing yield in the criterion), use that. The FE Reference will list Modified Goodman and Soderberg equations, so you can verify form if needed.

3. **Plug into the equation:**

   For Goodman: compute $\frac{\sigma_a}{S_e} + \frac{\sigma_m}{S_{ut}}$.

If the problem asks "will it fail?" just see if this sum is >1 (fail) or <1 (safe). If asks for factor of safety, solve $n = \frac{1}{\frac{\sigma_a}{S_e}+\frac{\sigma_m}{S_{ut}}}$.

For Gerber: compute $\frac{\sigma_a}{S_e} + (\frac{\sigma_m}{S_{ut}})^2$ and compare to 1, or solve quadratic for unknown.

For Soderberg: $\frac{\sigma_a}{S_e} + \frac{\sigma_m}{S_y}$ compare to 1 similarly.

4. **Interpret the result:**

   If factor of safety n comes out, say, 0.8, that means failure (since FS < 1). If it comes out 2, the design is quite safe (it can double the stress and still be at the limit). The exam might have you choose the closest integer or something.

   If just asking safe/unsafe, respond accordingly. Possibly also mention if yielding would occur first (e.g., if $\sigma_{\max}/S_y$ gives a smaller safety factor than the fatigue n, yielding is the governing failure mode).

By analyzing term by term: $\frac{\sigma_a}{S_e}$ is the fraction of endurance limit used by the alternating component, $\frac{\sigma_m}{S_{ut}}$ is the fraction of ultimate used by the mean component (for Goodman). If their sum is 1, you're at the limit. It's like saying "half the fatigue capacity used by alternating plus half by mean totals 100%." Gerber's $(\frac{\sigma_m}{S_{ut}})^2$ is saying the mean stress influence grows quadratically (less severe at first, more near the end).

A common point of confusion is why ultimate strength in a fatigue formula? It's because mean stress can cause static failure if high enough – S_{ut} sets that cutoff in Goodman. Also, ultimate tensile strength correlates empirically with the sensitivity to mean stress for many steels (higher S_{ut} often means the material can handle mean stress better relative to its endurance limit).

Practical Perspective: Many real-life machine parts (gears, shafts, springs) are designed such that under normal loading, σ_a is well below S_e. But if there's also a mean stress (like a rotating shaft that also carries a static load), the Modified Goodman helps ensure you account for that static load. In NAEX study sessions, we often emphasize practicing with Goodman diagrams: plot the point, see how close it is. Once you get it conceptually, these problems become almost plug-and-chug.

On the exam, take care to extract the correct values from the problem statement and match them to S_e, S_{ut}, etc. It's one of those areas where a minor mis-read can flip a safe design into a failing one or vice versa. But with the systematic approach above, you'll handle it smoothly!

K14.T02.S04 – Endurance Limit for Steels and Modification Factors

Topic Introduction: The **endurance limit (S_e)** is a fundamental property for fatigue calculations – especially for steels, which often exhibit a true fatigue limit. However, the raw endurance limit you might see in a textbook (like "half the ultimate strength") is for a very specific test specimen (polished, small, rotating beam). Real parts differ in surface finish, size, loading, temperature, etc. **Modification factors** are used to adjust the endurance limit to actual conditions. In this subtopic, we cover how to estimate a steel's endurance limit and apply factors for surface finish, size, load, temperature, reliability, etc., as expected on the FE Exam. Key points:

- **Estimating S_e' for Steels:** In absence of direct fatigue test data, a common approximation for the **unmodified endurance limit** S_e' of steel is roughly half the ultimate tensile strength. There's usually an upper cutoff; for very high-strength steels, the endurance limit doesn't keep rising beyond a certain point (around 700 MPa in absolute terms). So a typical rule: if $S_{ut} \leq 1400$ MPa, then $S_e' \approx 0.5\, S_{ut}$. If $S_{ut} > 1400$ MPa (i.e., > about 200 ksi), then S_e' maxes out around 700 MPa (around 100 ksi). This is because extremely strong steels tend to have no better endurance limit than ~700 MPa due to the nature of fatigue.
- **No true endurance limit for non-steels:** Note, this subtopic (and exam) focuses on steels because they have a well-defined endurance limit. Other materials like aluminum don't have a true "infinite life" endurance limit – they'll fail eventually at any stress level given enough cycles. For those, you'd need S-N curves or specified fatigue strengths at given life. The FE Mechanical Exam, however, mostly sticks to the classical case of steels for endurance limit calculations.
- **Modification Factors:** The laboratory S_e' (rotating beam, polished small specimen, 50% reliability typically) rarely matches your actual part's situation. We apply factors: **Surface factor (k_a)** for surface finish (because rough surfaces initiate cracks easier), **Size factor (k_b)** if the part is larger than the lab specimen, **Load factor (k_c)** for the type of loading (bending vs axial vs torsion), **Temperature factor (k_d)** if operating temperature affects strength, **Reliability factor (k_e)** if we want higher confidence (e.g., design for 99% of parts to survive instead of 50%), and sometimes a **miscellaneous factor (k_f or k_e in some notations)** for other effects (like corrosion, notch sensitivity, etc.). Multiplying these factors by S_e' gives the **modified endurance limit** S_e for the actual part.

Typical factor effects:

- Surface: Polished (ground) surfaces have k_a near 1.0, while rough as-forged surfaces might drop k_a to ~0.5 or less. Basically, smoother surface = higher fatigue strength.
- Size: Bigger parts (especially in bending/torsion) have lower endurance limit ($k_b < 1$) because a larger volume is under stress, increasing the chance of a weak spot. Standard lab tests use small ~8 mm diameter specimens; if your part is bigger, k_b reduces S_e.
- Load: Axial loading tends to be easier on fatigue than bending, and bending easier than torsion for the same nominal stress amplitude. Typically, k_c is 1.0 for bending (baseline), ~0.85-0.9 for axial, and ~0.6 for torsion. (The handbook lists $k_c = 0.577$ for torsion, which is basically the idea that shear endurance ~0.577 of bending endurance).
- Temperature: Mild temperatures have little effect ($k_d = 1$ at room temp up to 450°C per the handbook). If things got really hot, endurance limit would drop, but typical mechanical FE problems either ignore temp or give a factor.
- Reliability: Lab S_e' is statistical – usually ~50% of specimens survive infinite life at that stress. If you need 99% to survive, you reduce the design endurance limit. Common reliability factors: ~0.9 for 90% reliability,

~0.7-0.8 for 99.9%. (FE exam might not delve deeply here, but since it was mentioned, note that higher reliability requirement = lower S_e allowed.)

- Miscellaneous: This is a catch-all for things like corrosion, stress concentrations not accounted for elsewhere, etc. Often set to 1 if no info.

- **FE Exam usage:** You might be asked to calculate the endurance limit for a given part: e.g., "A steel rod has $S_{ut} = 800$ MPa, ground finish, diameter 20 mm in bending, 95% reliability. Estimate its endurance limit." You'd: compute $S_e' = 0.5 * 800 = 400$ MPa (since 800<1400), then find k_a for ground, k_b for 20 mm bending, k_c for bending, k_e for 95% reliability, multiply them all by 400 MPa. They might provide a table for surface finish or expect you to recall approximate values or formulas for k_a. The FE Reference Handbook includes a table of surface finish factors and formulas for these factors, so you can look them up quickly by keyword.

Exam Handbook Search Cues (Not affiliated with or endorsed by NCEES): *"endurance limit", "surface finish factor", "size factor", "fatigue modifying factors"*. (The handbook's Mechanical section has an "Endurance Limit Modifying Factors" table and formulas for k_b, etc. Searching those terms will land you there during the exam.)

Footnotes:

- *Notation:* Sometimes S_e' (pronounced "S e prime") is used for the **unmodified endurance limit** (laboratory specimen value), and S_e for the **modified endurance limit** (actual value for design). We'll use that notation here. k_a, k_b, k_c, k_d, k_e are common for factors, but be aware some sources use different letters for reliability or misc factors (e.g., k_e for reliability and k_f for miscellaneous, etc.). The FE Handbook uses k_a through k_e as listed, where k_e is the catch-all "miscellaneous effects" factor and reliability isn't explicitly a separate factor in their list (likely assumed if needed, it falls under misc or not considered unless given). If a reliability is given, you might treat it as one of the factors (just don't get thrown off by letter differences).

- *Units:* Endurance limits and ultimate strengths must be in the same units for the 0.5 rule to make sense. If S_{ut} is in MPa, S_e' comes out in MPa. The modifying factors $k_a, k_b, \ldots$ are dimensionless multipliers. For example, if $k_a = 0.8$ and $S_e' = 400$ MPa, then surface finish adjusted endurance limit is $0.8 * 400 = 320$ MPa. No unit conversion needed for factors – apply them directly.

- *Surface finish specifics:* The handbook provides empirical formulas: $k_a = a(S_{ut})^b$. These allow calculation of k_a for a given ultimate strength and finish. We have different (a, b) for different finishes. For instance, for a **ground** (polished) surface, $a = 1.58$, $b = -0.085$ (using S_{ut} in MPa). For an **as-forged** (very rough) surface, $a = 272$, $b = -0.995$ – which yields a much smaller k_a especially at high S_{ut}. It's not necessary to memorize those numbers; the exam likely either gives them or expects you to reference the handbook. But qualitatively, know ground > machined > hot-rolled > as-forged in terms of fatigue strength (ground being best, as-forged worst surface for fatigue).

- *Size factor specifics:* For rotating bending or torsion, the handbook gives piecewise: if diameter $d \leq 8$ mm, $k_b = 1$ (small sample, no reduction). For $8 < d \leq 250$ mm, $k_b = 1.189d^{-0.097}$ (for bending/torsion). This formula yields a gradually decreasing factor as size increases. If $d > 250$ mm, k_b bottoms out around 0.6–0.75. For axial loading, $k_b = 1$ regardless of size (because in axial, the entire cross-section is uniformly stressed, and size doesn't cause a stress gradient like bending does).

- *Load factor specifics:* The handbook lists k_c values clearly: 1.0 for bending (baseline), 0.923 for axial (for $S_{ut} \leq 1520$ MPa; if ultimate is higher, they even bump axial to 1.0, assuming high-strength materials handle axial similarly), and 0.577 for torsion. Essentially: bending and high-strength axial have full endurance, moderate axial a small reduction (~8% reduction), torsion a big reduction (~42% reduction).

- *Temperature factor:* Provided as 1.0 up to 450°C. That implies unless the part is literally red-hot, we don't reduce S_e. If an exam problem involves a high temperature beyond that, they should provide a factor or formula. Often fatigue problems assume room temp unless otherwise stated.

- *Reliability factor:* Not explicitly in handbook snippet we saw, but typically, for 90% reliability $k_r \approx 0.9$, 95% ~0.87, 99% ~0.82, 99.9% ~0.75. If needed, they'd likely give a value in the problem statement. If not given, assume the endurance limit you calculate is for 50% reliability (the "median" behavior). FE problems might specify "design for 95% reliability" and give you the factor or expect you to recall typical values. When in doubt, remember higher reliability -> multiply S_e by something less than 1 (like ~0.8–0.9).

- *Miscellaneous effects:* This could include things like a safety factor for uncertain factors, but usually, if nothing special is mentioned (corrosive environment, etc.), we take $k_{\text{misc}} = 1$. The handbook says use 1.0 in absence of known effects.

- *Scope:* These adjustments are for computing endurance limit for **infinite life design**. If the exam question is about finite life (e.g., how many cycles to failure at a certain stress), that's a different approach (using S-N curves or Miner's rule). However, FE Mechanical typically emphasizes infinite life design via endurance limit (because the reference info is oriented that way). So stick to that context unless the question explicitly shifts gear.

Workflow Passport – Modified Endurance Limit (No Proprietary Tables)

- **Purpose:** In fatigue design, a baseline fully-reversed endurance limit S_e'(lab/idealized) is adjusted to a design endurance limit $S_e$using dimensionless modification factors that reflect real conditions (surface, size, loading mode, temperature, reliability, and any other specified effects).

How to apply the method (workflow):

- **Surface Factor ($k_{surface}$):** Accounts for how surface condition/finish affects fatigue strength. If the problem statement gives k_{surface}, use it directly. If the permitted reference provides a correlation or lookup for k_{surface}based on material strength and surface category, use that reference during problem solving (do not memorize or reproduce coefficient tables in this guide).

- **Size Factor (k_{size}):** Accounts for size/volume and stress-gradient effects on fatigue strength. Determine the size measure required by the permitted reference (often tied to the stressed section and the load type). Use the factor value or method provided by the problem

statement or the permitted reference; avoid extrapolating beyond what the reference supports.

- Load Factor (k_{load}): Accounts for differences in endurance behavior under different cyclic stress states (e.g., bending vs axial vs torsion). Choose the factor corresponding to the alternating stress state that governs the fatigue failure mode, using values provided by the problem statement or the permitted reference.

- **Temperature Factor ($k_{temperature}$)**: Accounts for operating temperature effects. If temperature is specified and the problem/reference provides a temperature factor or method, apply it. If temperature is not specified (or the problem states to assume standard conditions), use $k_{\text{temperature}} = 1$as instructed.

- **Other Effects Factor k_{other}:** Captures additional influences not covered elsewhere (environment, coating, residual stress effects, etc.). Apply k_{other}only when the problem statement or permitted reference provides a usable value or clear instruction. If nothing is specified, treat $k_{\text{other}} = 1$unless the problem explicitly indicates otherwise.

- **Reliability Factor $k_{\text{reliability}}$**: If a reliability level is specified, apply the reliability adjustment factor from the permitted reference (or the value given in the problem). If reliability is not specified, follow the default assumption stated by the problem/reference for the baseline endurance limit.

- **Units & Publication Note**: Keep stress units consistent for S_e', S_e, and any strength values used by your chosen method. This guide intentionally does **not** reproduce proprietary coefficient tables or selection cutoffs for endurance-limit modifiers. Use the values supplied in the problem statement or consult the permitted reference during study/exam practice.

Typical Problem-Solving Moves:

- **Computing S_e**: Write the product first, then substitute factor values:

$$S_e = k_{\text{surface}} k_{\text{size}} k_{\text{load}} k_{\text{temperature}} k_{\text{reliability}} k_{\text{other}} S_e'$$

Use factor values provided by the problem statement. If values are not given, obtain them from the permitted reference for that problem context.

- **Comparing scenarios (conceptual):** Understand qualitatively which inputs typically improve fatigue performance (improved surface condition, reduced stress concentration, lower alternating stress, reduced size effect, etc.). If the problem asks for a numeric comparison, compute the relevant k-factors and compare the resulting $S_e$values using the same workflow.

Common Pitfalls:

- **Omitting a modifier**: Under time pressure it's easy to miss a factor. Use a consistent checklist (surface → size → load → temperature → reliability → other) and write the full product line before substituting values.

- **Unit inconsistency:** If a factor is computed using a correlation that depends on a strength input, confirm the correlation's required unit system and keep units consistent throughout. If the problem supplies factor values directly, use those values and avoid re-computing them.

- **Using an estimation rule outside its validity:** Some endurance-limit estimation rules are only valid over certain material/property ranges, and some references impose an upper limit on $S_e'$for very high-strength materials. If the problem/reference specifies a limit or range of validity, follow it. If not specified, avoid introducing unsupported caps or "rules of thumb" in a graded calculation.

- **Unspecified environment/effects**: If the problem mentions an effect but does not provide a numeric factor or a method to obtain one, do not invent a number. In calculation problems, apply only the factors you can justify from given data or the permitted reference.

- **Rounding too early / boundary handling**: Keep guard digits until the final step. If a parameter sits near a boundary in a reference method, follow the method's stated rule for boundaries (or use the exact expression required by that method). Avoid adding "conservative" numerical choices unless the problem explicitly instructs you to do so.

Equation Passport – Endurance Limit Estimation
(This ties the process together into a formula.)

- **Name & Purpose:** *Endurance Limit Estimation for Steels* – gives a quick way to compute the endurance limit for a steel component given its tensile strength and condition factors. It answers: "What alternating stress can this part indefinitely withstand?" Use this to get S_e which you will then use in fatigue criteria like Goodman.

- **Equations:**

1. **Base endurance limit ($S_e{}'$):**
For steel with ultimate strength S_{ut},

$$S_e' = \begin{cases} 0.5\, S_{ut}, & S_{ut} \le 1400 \text{ MPa } (\approx 200 \text{ ksi}) \\ 700 \text{ MPa } (\approx 100 \text{ ksi}), & S_{ut} > 1400 \text{ MPa} \end{cases}$$

as an estimate. (If actual test data is given, that overrides this estimate.)

2. **Modified endurance limit (S_e):**

$$S_e = k_a\, k_b\, k_c\, k_d\, k_e\, S_e'$$

Here k_a = surface factor, k_b = size factor, k_c = load factor, k_d = temperature factor, k_e = miscellaneous/reliability factor. Apply all relevant factors by multiplication. The resulting S_e is the endurance limit to use in design calculations (like Goodman equation).

- **Variables and Units:**

- S_{ut} – Ultimate tensile strength of the material (MPa or psi). If using the piecewise formula above, use MPa with the given numeric cutoffs (1400 MPa, 700 MPa). (In USCS, the equivalent is $S_{ut} \le 200$ ksi, then $S_e{}' = 0.5 S_{ut}$, capped at 100 ksi.)
- $S_e{}'$ – Unmodified endurance limit (MPa or psi). This is for a polished rotating-beam specimen (approx 8 mm diameter, 50% reliability, room temp).
- S_e – Endurance limit for the actual part (MPa or psi), after

applying factors.
- k_a – Surface finish factor (dimensionless, $0 < k_a \leq 1$). E.g., ground (~0.9–1.0), machined (~0.7–0.9), hot-rolled (~0.5–0.8), as-forged (~0.3–0.7) depending on S_{ut}.
- k_b – Size factor (dimensionless, ≤ 1). 1 for small parts, decreasing for larger diameters in bending/torsion. No reduction for axial (so 1).
- k_c – Load factor (dimensionless). ≈1 for bending, ~0.9 for axial, ~0.58 for torsion (for steel).
- k_d – Temperature factor (dimensionless). 1 up to a moderate temp (steel: 1 up to 450°C). If higher temp given, use provided factor or chart.
- k_e – Miscellaneous factor (dimensionless). 1 if not otherwise specified. Could include reliability: e.g., for 99% reliability $k_e \approx 0.814$. The problem will specify if a reliability factor is needed; if so, include it here (or as separate k_r).

- **Assumptions & Scope:**

- These formulas are empirical rules for **steel**. For other materials (aluminum, etc.), the exam usually won't have you use these – they might directly give a fatigue strength at a certain life instead. If you suspect the material isn't steel and no endurance limit given, be cautious; likely the problem will give needed info.

- The base $S_e{}'$ formula assumes a fully reversed bending test on a polished specimen. The factors adjust for differences from that baseline. - Valid for high-cycle (infinite life) regime. If the stress is above S_e but below yield, it doesn't mean immediate failure; it means finite life. But on the exam, we typically design for infinite life or check against infinite life criteria. If they wanted finite life, they'd need to supply additional data (like an S-N curve or specific cycle count).

- **Limit Tests:**

- **If S_{ut} is low:** e.g. a low-strength steel with $S_{ut} = 500$ MPa. Then $S_e{}' = 0.5500 = 250$ *MPa. If it's ground, small, bending, that might all be near 1, so* $S_e \approx 250$ *MPa. If it's as-forged, large, torsion, at temp, maybe* $k_a = 0.6, k_b = 0.8, k_c = 0.577, k_d = 1, k_e = 1$*, then* $S_e \approx 0.60.80.577250 \approx 69$ MPa – a huge reduction, showing how harsh conditions can drastically lower fatigue strength. Always expect S_e to be quite a bit lower than S_{ut}, typically.

- **If S_{ut} is extremely high:** say 1800 MPa (metals like shot-peened ultra high strength steel). Use the cap: $S_e{}' = 700$ MPa. Even if surface is superb, etc., S_e won't exceed ~700 MPa times factors (which are ≤1, so actually S_e will be at most 700 MPa and likely less). This indicates even the strongest steel cannot endure infinite cycles much beyond ~700 MPa without failing – a material science reality.

- **Applying all factors = 1:** If by chance the part is identical to the test conditions (polished, small, bending, room temp, standard reliability), each factor is 1, so $S_e = S_e{}'$. E.g., a tiny polished specimen in bending in your design basically retains the full 0.5 S_{ut}. This seldom happens in real machines (they're usually rougher or bigger), but it's a baseline check.

- **Use vs. Sibling Equations:** This *estimation* is used when you don't have actual fatigue test data for your part. If the exam problem *gives* an endurance limit or says "the endurance limit is X MPa," use that directly instead of calculating. The formula is to be used when you have to derive S_e. Also, be mindful: sometimes for a finite-life question, they might give a formula like $S_f(N) = S_e{}'(N/10^6)^{-b}$ etc., but that's outside the infinite-life scope. In summary, use these equations for infinite life design problems.

- **Common Exam Traps:**

- **Confusing S_e with S_y or S_{ut}:** The notation can jumble in your head. S_e is much lower, don't accidentally plug S_y into a Goodman equation thinking it's endurance limit, for example. The endurance limit is typically the smallest of the three strengths (for steel, often S_e ~ half of S_{ut}, and S_y might be somewhere in between depending on alloy). Some exam distractors might include a value and label it ambiguously; pay attention to units and context (if it says "endurance limit" it's S_e, if "yield strength" that's different).

- **Computing k_a incorrectly:** This is the one factor that requires a calculation. A common mistake is to plug S_{ut} in wrong units or to confuse which a, b to use. Also, if S_{ut} is given in, say, psi (like 100 ksi), and you decide to use the MPa constants, you must convert 100 ksi to 690 MPa first. Alternatively, use the kpsi constants with 100 (since 100 kpsi = 100 in those units). The exam might avoid this by giving SI throughout, but just be careful.

- **Neglecting the size cutoff:** The formula $1.189d^{-0.097}$ is empirically derived up to 250 mm. If your part is larger, the handbook just gives a range (0.6 to 0.75). If they expect an answer, they might assume the conservative end (0.6) or tell you to assume a certain value. If not, using $d = 250$ in the formula as a proxy might be acceptable. But be mindful if d is huge, mention that k_b is capped.

- **Forgetting a factor or double-applying:** Sometimes confusion arises between factors and other safety considerations. For instance, reliability can be handled as a separate safety factor on life or as a factor on stress. Don't double-reduce for the same effect. If you included a reliability factor in k_e, don't also reduce the allowed stress again elsewhere for reliability. Conversely, if they gave a safety factor for design (like design for FS=2 in fatigue), that's separate from reliability factor – one is to ensure stress is half the allowable, the other is to ensure more specimens survive. Keep those concepts separate.

- **Applying factors to wrong property:** These k factors apply to the endurance limit *only*. Do not apply them to ultimate or yield values. For example, you don't reduce S_{ut} by k_a or such – they're specifically characterizing how S_e differs from the ideal $S_e{}'$. A mistake would be in a Goodman equation plugging $k_a S_{ut}$ for something – no, you always apply factors to $S_e{}'$.

- **Arithmetic slips in multiplication:** It's not uncommon to have several factors like 0.8, 0.9, 0.7… When multiplied, the result could be significantly smaller. It helps to sanity-check: if most factors are around 0.8, and you have five of them, S_e might be roughly $(0.8^5) \approx 0.33$ of $S_e{}'$. If you got something like 0.8 of $S_e{}'$, you likely missed a factor. Or if you got 0.05 of $S_e{}'$, maybe a miscalc (unless one factor was extremely low). So sense-check: typical combined factor might reduce $S_e{}'$ by 30-60%. If your product is out of that range, recheck the numbers.

Explanation & Analysis: The process of determining endurance limit is a bit like accounting – you start with an initial "budget" (the lab endurance limit, roughly half of ultimate strength for steel), then you start subtracting for every "bad news" factor: surface roughness? subtract some (multiply by <1), big size? subtract some, etc. Each factor tells a story:

Surface factor (k_a): Machining marks or roughness are prime sites for crack initiation. A mirror-polished part can endure higher stress

for infinite life than a rough one. That's why k_a for polished is close to 1, and for as-forged can be as low as ~0.3 if S_{ut} is high (meaning a strong steel is actually **more** sensitive to surface condition in percentage terms; a high strength steel benefits greatly from good finish, otherwise its strength potential is wasted by surface flaws). In practical terms, if you need to improve fatigue life, improving surface finish (or adding surface treatments like shot peening) is very effective – something to recall for conceptual questions.

Size factor (k_b): Imagine a large beam vs a small rod – the large beam has more volume where a nasty inclusion or microcrack could lurk, and bending stress is highest at the surface but a larger diameter means more material at near-peak stress. Statistically, bigger things fail sooner in fatigue for the same stress. So we reduce S_e for large sizes. The formula $1.189d^{-0.097}$ is a result of fitting many experiments; you don't need to derive it, just apply it. For axial loading, interestingly, size doesn't matter as much because the whole cross-section is equally stressed (no gradient), and smaller volume effect is not as pronounced in those cases (or already accounted by surface since any part size has the same surface stress in axial).

Load factor (k_c): This accounts for the **type of stress**. For the same amplitude of stress, axial is actually the most damaging (all fibers loaded fully), torsion is less damaging in terms of failure for a given shear vs normal stress. Actually, one way to recall: a fully reversed torsion leads to a principal stress of half that magnitude (like earlier, pure shear yield vs tension yield difference). So $k_c = 0.577$ for torsion basically reflects that equivalent alternating shear is only ~57.7% as damaging as the same value of alternating tension (it's like an analog to von Mises in fatigue context). Bending is usually taken as baseline (most fatigue tests are rotating bending). Axial is slightly more damaging than bending because in bending, surface sees max stress but core sees less; in axial, entire cross-section at max stress every cycle – so k_c is slightly less than 1 for axial (0.923 if S_{ut} not super high).

Temperature factor (k_d): Metals at moderate temperature (up to 450°C for steel) don't lose fatigue strength. Above that, they might. The exam likely won't go deep here unless they give a factor or mention it. But if you think about creep etc., that's out of scope; so k_d is usually 1.

Reliability factor: If you want to be sure 99.9% of parts won't fail, you design with a lower stress than the median endurance limit. It's like using a lower percentile from a distribution of fatigue limits. The ones I stated (90% -> ~0.9, 95%->0.868, 99%->0.814, 99.9%->0.753) come from standard tables. If not given, don't fret, but since the outline mentioned reliability, just be aware of concept: more reliability = lower S_e.

Miscellaneous (k_e in handbook terms): Accounts for factors like a corrosive environment (corrosion can accelerate crack growth drastically), or a notch that isn't otherwise accounted by stress concentration (though usually you'd handle notches by computing a notch factor separately). In design, we often set $k_e = 1$ unless we have reason to adjust. On the exam, unless they tell you, assume 1.

All factors multiply, which means if you have several less-than-ideal conditions, the endurance limit drops significantly. For example, consider a high-strength steel (S_{ut} high) that is as-forged, diameter 100 mm, in torsion, 99% reliability:
- $S_{ut} = 1600$ MPa, so $S_e' = 700$ MPa (capped).
- Rough as-forged: from table roughly $k_a \approx 0.3$ (high S_{ut}, worst finish).
- Size 100 mm: $k_b = 1.189 * (100)^{-0.097} \approx 0.85$ (just estimating, it'll be less than 1). Actually at 100 mm likely around 0.75 (since at 250 mm it's ~0.6). Let's say $k_b \sim 0.8$.
- Torsion: $k_c = 0.577$.
- Room temp: $k_d = 1$.
- 99% reliability: $k_r \approx 0.82$.
- Multiply: $S_e = 700 * 0.3 * 0.8 * 0.577 * 1 * 0.82$. Roughly: $700 * 0.113(productoffactors) \approx 79$ MPa. Wow, from an ultimate of 1600 MPa down to an endurance limit of ~79 MPa – that shows how punishing fatigue can be when conditions are not ideal. A part like that would need a huge safety factor or redesign to survive infinite cycles.

For exam purposes, usually the numbers aren't that extreme; maybe a moderate steel, machined finish, moderate size, etc., giving S_e maybe a few hundred MPa.

Special Note – Calculator Input: If calculating something like $k_a = 4.51(800)^{-0.265}$ *on a calculator: - For Casio, you'd do 4.51 × (800 ^ (-0.265)). The Casio can handle the fractional exponent directly. - For TI-36X, similar: use the y^x key for exponent. Mind parentheses: 800^(-0.265) – the negative exponent needs to be in the power. - On HP, you'd likely do 800 ENTER 0.265 CHS Y^X* 4.51 (in RPN). Either way, just be careful not to drop the negative or mis-type the exponent. You might cross-check by computing in steps: e.g., $800^{-0.265} = 1/(800^{0.265})$. Also ensure not to confuse "E" notation (for powers of ten) with exponents here – just a typical caution.

All said, determining S_e is often the **first step** in a fatigue problem. Once you have S_e, you plug it into Goodman or whatever. So don't shortchange this step; get it right so the final answer is correct. Practice a couple of these with different factors, and you'll be ready for whatever combination the FE exam throws at you!

Topic 03 - Deformation and Stiffness

Topic Introduction: This chapter covers **deformation and stiffness** in mechanical systems – how structural members stretch, compress, twist, and bend under loads. These concepts matter on exam day because many questions ask for deflections: how far a rod elongates, how much a shaft twists, or how a beam bends. Such deformations relate directly to stiffness (the resistance to deflection). Typical question archetypes include calculating an elastic deflection given a load, comparing stiffness of different materials or geometries, or combining deflections from multiple loads. The focus is on linear elastic behavior (within Hooke's law) – a safe assumption for most FE problems. You'll often use simple formulas (like δ = PL/AE for a rod, or the bending deflection formulas for beams) or the principle of superposition to get the answer quickly. Keep an eye on units and the exam handbook keywords so you can find the right formula fast.

K14.T03.S01 – Axial Deformation of Members (Tension/Compression)

Principle Introduction: When you pull or push on a member along its length, it **elongates or shortens**. This axial deformation is usually small but critical in tie rods, bolts, columns, and other structural or machine parts. Key insights:

- **Linear elasticity:** Within the elastic limit, extension is proportional to load – double the force, double the stretch. Remove the load, and the member returns to original length (no permanent deformation).
- **Stiffness factors:** A long member stretches more than a short one under the same force, and a thick (large cross-sectional area) or high-modulus material stretches less than a thin or low-modulus one. In other words, *more length = more deflection; more area or a stiffer material = less deflection*.
- **Design relevance:** Axial deflection matters for components like turnbuckle rods or support columns – too much stretch or compression can misalign parts or cause slack. On the FE, you might need to calculate this deflection to ensure it stays within allowable limits (or to find the spring constant of a rod modeled as a spring).

Exam Handbook Search Cues (Not affiliated with or endorsed by NCEES): *"uniaxial"*, *"deformation"*, *"elongation"*, *"Young's modulus E"*

Equation Passport: Axial Deformation Formula

Name and purpose: *Axial Deformation (Elastic Stretch)* – Computes the change in length δ of a prismatic member under an axial tensile or compressive load. This formula answers questions like: "How much will this rod extend under a given force?"

Equation (linear elastic):

$$\delta = \frac{P\,L}{A\,E}$$

Variables and units:

- P – axial force (tension $+$, compression $-$). SI unit: newton (N); US unit: pound-force (lbf).
- L – length of the member (along the load direction). SI unit: meter (m); US unit: inch (in).
- A – cross-sectional area of the member. SI unit: m²; US: in².
- E – Young's modulus (modulus of elasticity) of the material. SI unit: pascal (Pa, with typical values in gigapascals GPa); US unit: psi.
- δ – resulting extension $(+)$ or contraction $(-)$ of the member. SI unit: m (often reported in mm for convenience); US unit: in.

Assumptions and scope:

- **Linear elastic, homogeneous material:** The formula $\delta = PL/(AE)$ assumes Hooke's law holds (stress $\sigma = E\,\varepsilon$) and the material has a constant E over the length. It's valid up to the material's elastic limit (no yielding).
- **Uniform cross-section:** A is assumed constant along the member. For a stepped or tapered rod, break it into uniform segments and sum the deflections for each segment (superposition applies because of linearity).
- **Small deformations:** The change in length δ is small relative to L (typically true for metals under working loads). This ensures that the load P and geometry don't significantly change as the member deforms. (In other words, we don't need to consider second-order effects or any change in A or direction of P due to stretching.)

Limit checks: If $P \to 0$, then $\delta \to 0$ (no load, no deformation – passes sanity check). If the member's length L doubles, δ doubles (direct proportionality). If the cross-sectional area A is made huge or the material is extremely stiff ($E \to \infty$), then $\delta \to 0$ – the member would hardly deform, acting rigid.

Use vs. related formulas: Use this equation for **static axial loads** to find instantaneous elastic deflection. Do not confuse it with the **thermal expansion** formula $\delta_t = \alpha\,L\,\Delta T$ (for deformation due to temperature change). If a problem involves both load and temperature change, you can compute the mechanical δ from $PL/(AE)$ and the thermal δ_t separately and add them (again, superposition – provided the total strain is still small and elastic). Also, for axial *buckling* of slender columns, a different formula (Euler's buckling) is used to find load capacity – but if asked for *pre-buckling* elastic shortening under a load, $PL/(AE)$ is the right tool.

Common exam pitfalls:

- **Unit mix-ups:** Make sure P, L, A, and E are in consistent units. For example, in SI, if P is given in kN and A in mm², convert to N and m² before using the formula to get δ in meters. A common mistake is to plug in E in GPa and A in mm² directly – you'd end up off by a factor of 10^3 or 10^6. A quick check: 1 N/m² = 1 Pa, so if using mm and kN, convert: 1 kN = 1000 N; 1 mm = 0.001 m. Keep track of those conversions[^1].
- **Using wrong E or A:** Ensure you use the correct modulus for the material (e.g. steel $E \approx 200$ GPa, aluminum ~ 70 GPa) and the right cross-sectional area. If the member is a bolt or pipe, remember to use the **net**

area (root area for threaded sections, or annular area for pipes).

- **Sign convention confusion:** Typically, we take δ as positive for elongation (tension) and negative for shortening (compression). If the problem gives a compressive load, you can plug in P as a positive magnitude and understand the resulting δ will be a shortening (negative outcome conceptually). The formula itself will give a positive number for positive inputs, so just interpret appropriately.

Explanation (step-by-step): This formula comes from combining stress, strain, and Hooke's law. The **axial stress** is $\sigma = P/A$ and the axial **strain** (elongation per unit length) is $\varepsilon = \delta/L$. For linear elastic behavior, $\sigma = E\,\varepsilon$. Substituting: $P/A = E(\delta/L)$. Solve for δ: $\delta = \frac{P\,L}{A\,E}$. It's essentially Hooke's law in another form: think of the member as a spring – $P = k\,\delta$ with $k = AE/L$. A larger AE (stiffer material or bigger cross-section) means a larger spring constant k (harder to stretch), so δ is smaller. A longer L makes the spring "softer" (smaller k), so δ is larger – just like a longer spring stretches more easily.

In practical terms, if you have (for example) a 1.0 m long steel rod (cross-sectional area 1.0 cm², $E = 200$ GPa) under a 20 kN tensile load, you can compute its extension. First convert units: $20\sim\text{kN} = 20{,}000\sim\text{N}$, $1.0\sim\text{cm}^2 = 1.0 \times 10^{-4}\sim\text{m}^2$, $E = 200\sim\text{GPa} = 200 \times 10^9\sim\text{Pa}$. Now plug in: $\delta = \frac{(20{,}000\sim\text{N})(1.0\sim\text{m})}{(1.0\times10^{-4}\sim\text{m}^2)(200\times10^9\sim\text{Pa})} = 1.0 \times 10^{-3}\sim\text{m} = 1.0\sim\text{mm}$. That result is a small but noticeable elongation. It makes sense: no load, no stretch; a bigger load or a longer rod would give more stretch. Always reflect on the result: Is the deformation reasonable? If you got 1.0 *meter* instead of 1.0 mm, that's a red flag your units might be off by a factor of 10^3.

[^1]: *Unit Tip:* In USCS units, a common scenario is using P in kips (kilo-pounds) and A in in², with E in psi. Remember 1 kip = 1000 lbf, and typically E for steel is about 30×10^6 psi. If L is in inches, your δ will come out in inches. It's easy to mix up units in the rush of the exam – take a second to ensure consistency, or convert everything to base units (N, m, Pa or lbf, in, psi) before computing.

K14.T03.S02 – Torsional Deformation (Angle of Twist in Shafts)

Principle Introduction: When a shaft is subjected to torque (a twisting moment), it **rotates** slightly along its length – one end twists relative to the other. This **angle of twist** is usually measured in radians (for small twists, degrees can be used for intuition). It's important in machine design: excessive twist can cause gears to misalign, couplings to wobble, or timing issues in rotating machinery. Key points:

- **Linear torsion response:** For a solid or hollow circular shaft, the twist angle φ is proportional to the applied torque T and the shaft length L, assuming elastic behavior. If you double the torque, the twist doubles; a longer shaft accumulates more rotation under the same torque.
- **Torsional stiffness:** A shaft's ability to resist twisting depends on both its material properties and its geometry – specifically the shear modulus G (material stiffness in shear) and the polar moment of inertia J (which depends on cross-sectional shape). A larger diameter shaft (bigger J) or a material with higher G (like steel vs. rubber) will twist less under the same torque. In fact, the **torsional spring constant** of a shaft is $k_t = GJ/L$, analogous to axial $k = AE/L$.
- **Design considerations:** In the FE exam, you may be asked to find the angle of twist in a drive shaft or determine how misaligned two ends of a shaft become under load. Often, the problem gives you T, L, J, and G to plug into the formula. Ensure you use consistent units (e.g., N·m for torque and Pa for G in SI, or lbf·in and psi in US units) so that φ comes out unitless (radians). Also, check if the question asks for degrees – you'd then convert φ (rad) to degrees at the end (multiply by $180/\pi$).

Exam Handbook Search Cues (Not affiliated with or endorsed by NCEES): *"torsion"*, *"angle of twist"*, *"polar moment J"*, *"shear modulus G"*, *"torsional stiffness"*

Equation Passport: Torsional Twist Formula

Name and purpose: *Angle of Twist (Torsion)* – Calculates how far (in radians) one end of a shaft rotates relative to the other under an applied torque. Use this to find angular deflections in circular shafts, such as how much a drive shaft twists under load, or how misaligned two connected components might become.

Equation (uniform circular shaft):

$$\phi = \frac{T\,L}{G\,J}$$

Variables and units:

- T – applied torque (twisting moment). SI unit: newton·meter (N·m); US unit: pound-foot (lbf·ft) or pound-inch (lbf·in).
- L – length of the shaft (along the axis of twist). SI unit: m; US unit: in or ft.
- G – shear modulus of the material (rigidity modulus). SI unit: Pa (often GPa for metals); US: psi. (For reference, steel $G \approx 75$–80 GPa.)
- J – polar moment of inertia of the cross-section (a geometric property reflecting resistance to torsion). SI unit: m^4; US: in^4. For a solid circular shaft of radius r, $J = \pi\,r^4/2$. For a hollow tube with outer radius r_o and inner radius r_i, $J = \pi\,(r_o^4 - r_i^4)/2$. (The exam handbook provides J formulas as needed.)
- φ – angle of twist between the two ends of the shaft. **Unitless in radians** (rad). (To express in degrees, do $\varphi_{\text{deg}} = \varphi \times \frac{180^\circ}{\pi}$.)

Assumptions and scope:

- **Elastic, linear torsion:** The material obeys Hooke's law in shear ($\tau = G\,\gamma$). The formula $\varphi = TL/(GJ)$ comes from integrating the small-angle shear strain γ over the length. This holds until the material yields in shear. No permanent twist occurs if unloaded (the shaft returns to zero angle).
- **Circular cross-sections (or thin-walled approximations):** The formula is exact for circular shafts (solid or hollow). For non-circular sections (like rectangular shafts), the torsional deformation is more complex (non-uniform warping) and requires different formulas or correction factors (beyond typical FE scope).

The exam usually sticks to circular shafts or provides J for any given shape.

- **Uniform shaft:** J and G are taken as constant along the length. If a shaft has sections of different diameter or material (composite shaft), compute the twist in each section and sum them (each section i uses its own J_i, G_i, and L_i in $\varphi_i = T L_i/(G_i J_i)$). Superposition applies since the deformation is linear and each segment's twist just adds up.
- **Small angles:** φ is assumed small (in radians) such that $\sin\varphi \approx \varphi$ and the geometry isn't significantly changing. Practically, this is always the case for elastic twist – even a few degrees (0.05 rad) is fine. If the shaft were to twist excessively (plastic twist or helical buckling), this linear formula breaks down, but that's beyond what FE will test.

Limit checks: If $T = 0$, then $\varphi = 0$ (no twist with no torque – obvious, but good to verify). If the shaft is very short ($L \to 0$), $\varphi \to 0$ (a stubby shaft doesn't twist much). If G or J is very large, φ is very small – e.g. using a super-rigid material or a very thick shaft yields almost no angular deflection. These limits make sense physically. Also, note that $T/\varphi = GJ/L$ is the torsional stiffness constant k_t: as L increases, stiffness decreases (like a longer spring); as J or G increases, stiffness increases (harder to twist).

Use vs. related formulas: This torsion formula should be used for calculating *angle* of twist. Do not confuse it with formulas for torsional *stress* (like $\tau_{\max} = T r / J$) – though they stem from the same theory, they address different quantities. If an exam question gives you torque and asks for *rotation* or *angular deflection*, $\varphi = TL/(GJ)$ is the way to go. If it asks for *shear strain* or *stress* at a given radius, you'd use $\gamma = r\ \varphi / L$ or $\tau = T r / J$. Also, if the problem involves a **torsional vibration** or spring, you might see the same GJ/L appear as a stiffness in a frequency formula – but that's a dynamics context. Here we're focused on static twist.

Common exam pitfalls:

- **Using the wrong polar moment (J):** A very common mistake is to use the area moment of inertia I (from bending formulas) instead of the polar moment J. Remember, for torsion in circular shafts, $J = \pi d^4/32$ for a diameter d (which is $\pi r^4/2$). The exam might provide J explicitly or list formulas in the handbook. Double-check: polar moment J is about the shaft's axis, whereas I (second moment of area) is about a bending axis – they are not interchangeable (except for round sections where $I_{xx} + I_{yy} = J$).
- **Unit consistency for G:** G (shear modulus) is often given in gigapascals or psi. If T is in N·m and L in m, use G in Pa (N/m²) and J in m⁴ to get φ in radians. For example, plugging $G = 80$ GPa as 80×10^9 Pa, not as 80, is crucial. In US units, if T is in lbf·in and L in inches, use G in psi and J in in⁴ to get φ in radians. Keep track of those scientific notation factors.
- **Interpreting the result:** The formula gives φ in **radians**. It's easy to forget to convert to degrees if the problem expects it. For instance, $\varphi = 0.05$ radians is about $0.05 \times 57.3 = 2.86^\circ$. If an answer seems "too small," check if it's in radians and maybe convert to degrees to make sense of it. Conversely, if you erroneously treated φ as degrees in the formula, you'd be off by a factor of $\pi/180$. Set your calculator to *radian mode* when using this formula directly, or convert at the end.
- **Ignoring material or geometry changes:** If a shaft is composite (say, half-length in steel, half in aluminum) or has different sections, don't lump everything together. Compute twist for each section. The trap is to maybe average G or something – which is incorrect. The correct approach is piecewise: each segment $\varphi_i = T L_i/(G_i J_i)$, then sum. The linear superposition holds, but you must do it segment by segment.

Explanation: The torsional deformation formula comes from relating shear stress to shear strain in a circular shaft. For a shaft under torque T, the shear stress at radius r is $\tau(r) = \frac{T r}{J}$ (assuming $t > 0.1r$ for thick-walled, otherwise a thin-walled formula is used). The shear strain γ at that radius is $\tau/G = \frac{T r}{GJ}$. Geometrically, this shear strain γ relates to the angle of twist: $\gamma = \frac{r\varphi}{L}$ (the farther out at the radius, the more linear deflection for a given angle). Set these equal: $\frac{r\varphi}{L} = \frac{T r}{GJ}$. The r cancels (so every fiber rotates by the same angle φ), and you get $\varphi = \frac{T L}{G J}$. This assumes φ is small so that $\tan\varphi \approx \varphi$ in radians – which is valid for elastic twists.

In simpler terms, think of a driveshaft like a **coil spring**: a longer shaft (more coils) twists more easily (larger deflection), a fatter shaft (thicker coil) or stiffer material (stiffer spring) resists twist (smaller deflection). For example, consider a 1 m long solid steel shaft, 50 mm in diameter, under a torque of 1000 N·m. The polar moment $J = \pi d^4/32 = \pi\,(0.05\sim\text{m})^4/32 \approx 3.8 \times 10^{-6}\sim\text{m}^4$. Steel's $G \approx 80 \times 10^9\sim$Pa. Plug in: $\varphi = \frac{1000\,\text{N·m} \times 1.0\sim\text{m}}{(80\times10^9\sim\text{Pa})(3.8\times10^{-6}\sim\text{m}^4)} \approx 0.0033\sim$rad. That's about 0.19°. A fraction of a degree twist over 1 m – quite small, which is expected for a stout steel shaft under that torque. If the shaft were aluminum (lower G) or thinner (smaller J), φ would be larger. Always consider: does the result make sense? A huge angle (like 30°) for a metal shaft under moderate torque would be a red flag (likely indicating plastic twist or a calculation error). On the exam, typical twist angles are usually just a few degrees or less, since everything is kept within elastic limits.

K14.T03.S03 – Beam Deflection in Machine Elements (Bending)

Principle Introduction: Structural beams and machine components deflect when loaded transversely (in bending). This subtopic covers how to determine the **deflection of beams** – for example, how much a shaft supported at its ends sags under its own weight or under a gear's force, or how far a cantilever beam deflects at the tip. This matters because excessive deflection can cause malfunction: shafts might misalign bearings, gears might lose proper mesh, or a machine frame might interfere with moving parts. Key insights:

- **Elastic curve:** The deflected shape of a beam is often called the *elastic curve*. For small deflections, the curvature of this curve at any point is proportional to the bending moment $M(x)$ at that point: $\frac{1}{\rho} = \frac{M(x)}{E\,I}$, where $E\,I$ is the flexural rigidity. From this relationship, one can derive the deflection function $y(x)$ by integrating twice – a process given by $E\,I\ \frac{d^2 y}{d x^2} = M(x)$. In practice, you usually don't integrate from scratch on the FE exam; instead, you recall or look up standard deflection formulas for common load cases.
- **Standard cases and tables:** The exam handbook provides deflection formulas for common scenarios (simply supported beams, cantilevers, etc.) either

explicitly or via reference. For instance, a simply supported beam with a centered point load has a maximum deflection $\delta_{\max} = P L^3/(48 E I)$, and a cantilever with an end load has $\delta_{\max} = P L^3/(3 E I)$. Recognizing these classic patterns can save time. If a problem doesn't match a standard case exactly, you can often break the loading into pieces and superimpose results (next subtopic).

- **Design limits:** While strength (stress) often governs design, deflection criteria are also important. In machine design, deflections might be limited to ensure proper operation (e.g., a shaft might be required not to deflect more than, say, 0.1 mm at a gear to avoid noise). On the exam, you might be asked to compute the deflection and compare to a limit, or simply find the deflection at a point given loads and support conditions. Always identify the support type (simply supported, cantilever, fixed, etc.) and load type (point load, uniform load, etc.) to select or derive the correct formula.

Exam Handbook Search Cues (Not affiliated with or endorsed by NCEES): *"deflection of beams"*, *"elastic curve"*, *"E I bending"*, *"cantilever deflection"*, *"simply supported deflection"*

Equation Passport: Beam Deflection (Elastic Curve Equation)

Name and purpose: *Elastic Curve Differential Equation* – Relates the bending moment along a beam to its deflection shape. This is the foundational equation used to derive specific deflection formulas. While you might not solve it fully on exam day, understanding it helps you to approach non-standard cases or verify given formulas. It essentially tells us *"how a bending moment produces curvature, and hence deflection."*

Fundamental equation:

$$EI\,\frac{d^2y}{dx^2} = M(x)$$

Here $y(x)$ is the beam deflection as a function of position $x$along the beam, and $M(x)$is the internal bending moment as a function of x. Integrating once gives the slope $\theta(x) = dy/dx$ and integrating twice gives the deflection $y(x)$. The integration constants are determined by boundary conditions (supports geometry).

Variables and units:

- E – Young's modulus (elastic modulus) of the beam material (Pa in SI; psi in US). Same E as in axial problems, but here it resists bending.
- I – Second moment of area (area moment of inertia) of the beam's cross-section, taken about the neutral axis for bending (m^4 in SI; in^4 in US). It quantifies the beam's geometric stiffness in bending. (E.g., for a rectangle of width b and depth h bending about the horizontal axis, $I = b\,h^3/12$.)
- $M(x)$ – Bending moment at position x (N·m in SI; lbf·ft or lbf·in in US). Sign convention: typically, positive M produces concave-up deflection (tension in bottom fibers).
- x – Position along the beam (m or in).
- $y(x)$ – Deflection of the neutral axis at x (m or in). d^2y/dx^2 is the curvature of the beam.

Assumptions and scope:

- **Small deflections, linear material:** The equation $EI\,y'' = M(x)$ assumes small rotations and deflections so that beam geometry doesn't significantly change during bending. It's derived from the Euler-Bernoulli beam theory (no shear deformation considered for slender beams). Material is linear-elastic (Hooke's law in tension/compression and no yield in fibers). These conditions hold for most exam problems – they won't involve large deflection effects or plastic hinges unless explicitly stated (and if so, they'd provide additional info).
- **Proper support conditions for integration:** To solve $y(x)$, use the boundary conditions appropriate to the supports: for example, a simply supported beam has $y = 0$ at the supports; a cantilever has $y = 0$ and $dy/dx = 0$ at the fixed end (zero deflection and zero slope); etc. The exam might not have you do the full integration, but recognizing BCs is key to using tabulated formulas correctly (e.g., knowing a cantilever's free end has max deflection and nonzero slope).
- **Superposition validity:** Because the governing equation is linear, the deflections from multiple loads can be added. The principle of superposition (next section) is implicitly assumed valid – which requires that deflections are small and the material stays elastic. If these assumptions hold (they do in exam scenarios), you can safely sum effects of separate loads.

Limit tests: If there is **no bending moment** ($M(x) = 0$ everywhere, e.g., no transverse loads on a simply supported span), then $y'' = 0$. Integrating gives a straight-line deflection function: $y(x) = Ax + B$. The constants would be set by supports – usually yielding $y(x) \equiv 0$ (no deflection at all) if the beam truly has no load. This checks out: no load, no bending. Another check: if the beam is very stiff ($E \to \infty$ or $I \to \infty$), the equation suggests $y'' \to 0$ for a finite M – meaning an infinitely rigid beam doesn't curve (zero deflection), as expected. If the beam is long and flexible (small EI), a given moment yields a larger curvature y'', hence more deflection – again matching intuition.

Using this vs. direct formulas: In practice, you rarely integrate this equation during the FE exam because common cases have known solutions. Instead, you'll **use this equation conceptually** to understand how deflection behaves, or you'll rely on results derived from it. Use this differential form when faced with an unusual load/distribution or a multi-step problem (like deriving an expression for $y(x)$ for a custom load). Otherwise, jump to the **standard deflection formulas** if the scenario matches. For example, for a uniformly loaded simple beam or a cantilever, it's faster to recall the formula than to derive it from scratch. The exam handbook might list some formulas (often in a table or section for "Beam Deflection") – get familiar with those entries so you can quickly find, say, "cantilever deflection".

Common exam traps:

- **Mixing up cases:** It's easy to plug the wrong formula if you confuse support conditions or load configurations. For instance, $\delta_{\max} = P L^3/(48 E I)$ is specific to a centered point load on a simply supported beam. That formula *does not* apply to a cantilever or to an off-center load. Similarly, a uniform load has different coefficients (e.g., simply supported with uniform load: $\delta_{\max} = 5\,w\,L^4/(384\,E\,I)$). Make sure the scenario matches the formula. When in doubt, derive quickly with $EIy'' = M(x)$ for partial credit or logical elimination.

- **Sign and direction:** In using superposition or writing $M(x)$ piecewise, be careful with sign conventions. If you set up the $M(x)$ equation incorrectly (signwise), you'll integrate to a wrong deflection shape. A common pitfall is the sign for moments in regions of a beam – for example, assuming a positive curvature when it's actually negative. The exam usually avoids overly complex sign scenarios, but just remember: consistent sign convention (usually, assume sagging is positive M and downward deflection is positive y) and stick to it.
- **Units in deflection formulas:** Just as with axial and torsion, keep units consistent. Often, E and I are the culprits: if E is in GPa, convert to Pa; if I is given in cm⁴, convert to m⁴ (1 cm⁴ = 10^{-8} m⁴!). The outputs are often small lengths (mm or in), so a calculator slip with exponents can lead to wildly wrong answers (e.g., confusing 10^{-3} with 10^{-6}). A quick mental estimate can help – if a steel beam of a few meters gets a deflection answer of 2 meters, something's off! Expect deflections in the order of maybe 1/1000 of the span for typical loads (just a rough sense).

Variations and typical values: The elastic curve equation yields different deflection formulas depending on loading and support: here are two common results worth remembering (they can save you time or serve as a check):

- **Simply supported beam, point load P at mid-span:** $\delta_{\max} = \frac{P L^3}{48 E I}$. The maximum deflection occurs at the middle. The rotation (slope) at the supports is $\theta_{\text{support}} = \frac{P L^2}{16 E I}$.
- **Cantilever beam, point load P at free end:** $\delta_{\max} = \frac{P L^3}{3 E I}$, at the free end. The rotation at the free end is $\theta_{\max} = \frac{P L^2}{2 E I}$. (And at the fixed end, $y = 0$ and $\theta = 0$ by boundary condition.)

Similarly, for a uniformly distributed load w on a simply supported beam, $\delta_{\max} = \frac{5 w L^4}{384 E I}$ at mid-span. These formulas are provided in many references and are derived by integrating $EIy'' = M(x)$ for the respective $M(x)$ functions. **Know the pattern:** deflection grows with L^3 (or L^4 for distributed loads) – span length has a *huge* effect; and deflection shrinks with larger $E\,I$ – stiffness matters. On the exam, even if you forget an exact coefficient like 48 or 384, you can often eliminate wrong answers by dimensional analysis or extreme case reasoning (e.g., a cantilever with end load should deflect more than a simply supported with center load, all else equal – indeed $1/3$ vs $1/48$ factor reflects that).

Explanation: To solve a beam deflection problem, **identify the loading and supports**. If it's a standard case, recall or find the formula. For example, say a problem gives a cantilever 2 m long with a 5 kN downward force at the free end, and asks for deflection at the tip. Recognize this as the classic cantilever case – use $\delta = P\,L^3/(3\,E\,I)$. Plug in $P = 5000$~N, $L = 2$~m, and the given E, I (they would provide those, or material and cross-section to compute them). Do the math carefully (watch units) to get δ (likely in mm). If it's *not* a classic case (maybe a point load not at the center of a span, or two different loads), break it into parts: treat each load separately, find deflections (perhaps using a formula for each or integrating if needed), then add them (superposition).

The differential equation $EIy'' = M(x)$ is there if you need to derive the deflection function $y(x)$ yourself. A quick outline of that process: write $M(x)$ as a function of x (this may be piecewise if the load is not uniform). Integrate once: $EI\,\frac{dy}{dx} = \int M(x)\,dx + C_1$ (which gives the slope $\theta(x)$). Integrate again: $EI\,y(x) = \int \theta(x)\,dx + C_2$. Use boundary conditions (at supports, or symmetry conditions) to solve for C_1, C_2. This yields $y(x)$. For instance, for a simple beam with a mid-span load, you'd do this in two segments (left of load and right of load) and match conditions at the load. It's a bit lengthy, which is why using known formulas is preferable during the exam. However, knowing that $y'' = M/(EI)$ helps you double-check if a formula makes sense: if you plug the deflection equation back in by twice differentiating, you should get the original moment diagram.

Always reflect on deflection results: Does the deflected shape look right (e.g., zero deflection at pinned supports, smooth and continuous curve)? Does the sign make sense (downwards vs upwards)? And is the magnitude reasonable? These sanity checks can catch mistakes early. Remember, in the **exam scenario**, you often have the reference handbook – you might find a "Beam Deflection" table in it. The search cues like "simply supported beam deflection" or "cantilever deflection" will point you to those formulas quickly. Practice using those cues so you're comfortable looking up what you need under time pressure.

K14.T03.S04 – Superposition of Deflections (Combined Loading)

Definition/Note Passport: Principle of Superposition

- **Plain-language definition:** The principle of superposition says that in a linear elastic system, the deflection from several loads applied simultaneously equals the sum of the deflections produced by each load applied separately. In formula terms, if load A alone causes deflection δ_A at some point and load B alone causes δ_B, then under A + B simultaneously, the deflection at that point is $\delta_{\text{total}} = \delta_A + \delta_B$ (assuming the structure's response is linear and the deflections are measured in the same direction).

- **Where it matters (exam impact):** This concept is your go-to strategy for **combined loading** problems in bending (and also for combined axial + thermal strains, etc.). Many FE exam questions simplify to applying superposition. For example, a beam might have two point loads at different locations – you can find the deflection from each load separately (using formulas or calculations) and add them. Or a shaft might have two torques – find each twist and sum. Essentially, any time you see **"multiple loads"**, think superposition, provided the problem context is elastic (which it almost always is on the FE). The exam may not explicitly say "use superposition," but it's often the implied method for solving combined load deflections quickly. Recognize linearity cues: small deflection assumption, material stays in elastic range, etc., all enable superposition.

- **Pitfall or confusion point: Superposition only works under linear conditions.** Students sometimes try to apply it blindly. Remember the two caveats spelled out in theory: (1) Each effect must be linear with its load (no exponents, no yielding, etc.). If doubling a load doesn't double the deflection (e.g., post-yield or a geometric nonlinearity), superposition fails. (2) The deformations must be small enough that they don't alter how other loads act. That means you can't superimpose deflections accurately if, say, a beam deflects so much that a second

load's leverage changes. On the FE Exam, you won't likely encounter grossly nonlinear situations, but keep in mind: *if there's any plastic deformation, large deflection, or contact/nonlinearity, superposition is not valid*. In linear elastic realm, though, it's perfectly valid and extremely useful. Another point of confusion: superposition applies to deflections and *also to internal forces* in linear systems. For example, if you need to find bending stress with two loads, you can add the bending moments from each load then compute stress. Just be clear: it's the responses that add, not the loads acting in some weird combined way.

- **Micro-check:** True or False? *"If a beam deflects 2 mm under load A and 3 mm under load B (applied separately), it will deflect 5 mm under both loads applied together (within the elastic limit)."* – **True.** (That's exactly superposition. If you got something else, reconsider linearity.) As a quick mental check on linearity: ask "Does doubling this load double the deflection?" If yes (and no thresholds are crossed), superposition will hold for combinations of loads. If not (e.g. something starts yielding at higher load), then you're out of the linear zone and simple addition won't work.

Exam Handbook Search Cues (Not affiliated with or endorsed by NCEES): *"superposition"*, *"combined loads deflection"*, *"linear superposition"*

Applying Superposition – Explanation & Analysis: On the exam, using superposition typically involves **breaking a complex problem into simpler ones**. For instance, suppose a simply supported beam has two point loads at different positions. There might not be a single formula in the handbook for "two loads at these specific positions," but you likely have a formula for one point load. So treat it as two separate cases: Case 1 with load P_1 (at its position) and Case 2 with load P_2 (at its position). You find the deflection at the point of interest (or the maximum deflection, or whatever is asked) for each case individually. Then add them up. Make sure to add *algebraically* – if the deflections are in the same direction (both downward, say), they add. If somehow one load caused an upwarp (not common unless you have a preload or something), you'd subtract as appropriate.

For an example, let's do a quick one: A cantilever beam has an end load and also a uniformly distributed load. You know the end load alone gives $\delta_{\text{end}} = P\,L^3/(3EI)$ downward. The uniform load alone gives $\delta_{\text{uniform}} = w\,L^4/(8EI)$ downward (for a cantilever). If both loads act, the *total* deflection at the tip = $P\,L^3/(3EI) + w\,L^4/(8EI)$ (downward). You just add because both loads cause downward deflection. This is much easier than trying to derive a new formula in one go for "end load + uniform load" – superposition did the heavy lifting by letting us use two simpler known results.

Why it works: Mathematically, the beam equation $EI\,y'' = M(x)$ is linear. If $M(x)$ can be split into $M_1(x) + M_2(x)$ from two loads, the general solution $y(x)$ splits into $y_1(x) + y_2(x)$. The integration constants sort out with linear conditions. Physically, each load "sees" the structure as if the other load wasn't there (again, as long as geometry and material aren't altered by that other load's presence). So the deformed shape under both is just the sum of the two individual deformations.

One more check: ensure you apply superposition to compatible measures. For example, if asked for deflection at a specific point, find each load's deflection at that point, then add. If asked for an entire deflected shape, you can even add functions $y_1(x) + y_2(x)$. Just be cautious with internal reactions – superposition works for those too, but if you, say, remove a support (making a statically indeterminate structure determinate via "force removal"), that's a different technique (compatibility and superposition used in methods like force method). The FE likely won't delve into indeterminate by superposition explicitly without guiding you. But straightforward cases of "multiple loads, find deflection/stress" are prime candidates for superposition.

When superposition *doesn't* apply: If you had a problem where, say, a beam has a large deflection that significantly changes how a second load behaves, or contact problems (one load might cause contact that prevents deflection from another load beyond a point), then it's not linear. But these are advanced scenarios outside the FE Mechanical scope. For the exam, you can safely assume everything is linear unless explicitly told otherwise.

In summary, **superposition is a powerful, simple concept**: use it whenever you can decompose a problem. It reduces complexity and leverages known solutions. It's essentially the idea of "build the answer from known building blocks." Practice identifying those building blocks (a single point load case, a uniform load case, an axial load case, etc.), and exam problems that initially seem complicated can turn into a couple of quick look-ups and additions. It not only saves time but also reduces error, because you're applying well-established formulas rather than doing complex algebra under pressure.

Topic 04 - Springs

Topic Introduction: Springs are mechanical devices used to store energy and resist forces through elastic deformation. In the FE Mechanical Exam, you'll encounter helical **coil springs** (typical compression or tension springs) that obey Hooke's law, meaning force is proportional to deflection. Mastering spring formulas is important for solving questions about how far a spring will compress under a load, how stiff a spring is, or how multiple springs combine. On exam day you might be asked to compute a spring's **stiffness (spring constant)** from its geometry, find the **deflection** under a given force, or determine an **equivalent spring constant** for springs in series/parallel. Being comfortable with the spring equations and understanding how geometry (wire diameter, coil diameter, number of coils) and end conditions affect spring behavior will help you quickly tackle these problems. Think of a car suspension spring versus a pen spring – knowing *why* one is stiffer than the other (geometry and material) makes the formulas easier to apply.

K14.T04.S01 – Helical Spring Constant & Deflection

Principle Introduction:

- A helical coil spring (compression or extension type) follows a linear force–deflection relationship (Hooke's law). The spring exerts a force **F** proportional to its change in length **Δ**: $F = k\,\Delta$. Here k is the spring's stiffness or **spring constant**, which quantifies how much force is needed per unit deflection.

- The spring's stiffness is determined by its material's shear modulus and the spring's geometry. **Stronger material (higher shear modulus G) or "beefier" geometry (thicker wire, smaller coil diameter, fewer coils)** makes for a stiffer spring (higher k). In contrast, a slender spring (thin wire, wide coil, many coils) is more compliant (lower k).

- **Key formula:** For a helical coil spring, the spring constant k can be calculated from geometry and material. This lets you find how a given force will compress or stretch the spring. The same formula applies to both compression and tension helical springs (ignoring any special end hooks for tension springs).

- On the FE Exam, you'll often use this formula in two steps: first compute k from the spring's dimensions and material, then use $\Delta = F/k$ to find deflection under a given force (or $F = k\,\Delta$ to find force from a compression). It's a straightforward plug-in once you identify the correct values for wire diameter, coil diameter, number of active coils, etc.

Equation Passport – Helical Coil Spring Rate – computes the linear stiffness of a coil spring from its material and geometry.

Formal Equation:

$$k = \frac{G\,d^4}{8\,D^3\,N},$$

where this formula gives the spring rate k in units of force per length (e.g. N/m or lbf/in). (Once k is known, deflection is found by $\Delta = F/k$.)

Variables and Units:

- k – spring constant (spring rate or stiffness), typically in **N/m** (SI units) or **lbf/in** (US customary).
- G – shear modulus (modulus of rigidity) of the spring material, in **Pa** (N/m²) or **psi**. (For steel, G is around 75–80 GPa.)
- d – wire diameter (the diameter of the spring's wire cross-section), in **m** (SI) or **inches** (US).
- D – mean coil diameter (the diameter of the spring's helix measured center-to-center of the wire), in **m** or **inches**.

  Note: The **mean** diameter D is the outer diameter minus one wire diameter (or inner diameter plus one d).
- N – number of active coils (dimensionless count). This is the number of coils that deform under load. (It may be less than the total coils if the end coils are touching or fixed – see Subtopic 2.)

Assumptions and Scope:

- The spring is made of an **elastic material** and is operating in its linear elastic range (no yielding of the wire). In other words, Hooke's law holds until the spring's deflection becomes too large.
- Formula assumes a **round-wire helical spring** with coils that are close enough to approximate a continuum (common for standard springs). Unusual spring types (e.g. flat spiral springs, Belleville washers, or torsion bars) use different formulas beyond this scope.
- The coils are not **compressed to solid contact** during operation. The formula for k is valid when coils can freely deflect; if the spring is compressed to its **solid height** (all coils touching), the relationship changes (effectively k becomes infinite at that point because it can't compress further).
- Applies to both **compression springs** (which shorten under load) and **extension springs** (which lengthen under load), as long as we're considering the coil's stiffness itself. (Extension springs often have initial tension and hooks, but the coil's spring rate still follows this formula.)

Limit Tests (Sanity Checks):

- If the wire diameter $d \to 0$ (very thin wire), then $k \to 0$. A vanishingly thin wire offers essentially no resistance – this makes sense, as a tiny spring is very easy to compress.
- If the coil diameter D grows very large (spring is **wider** and looser), $k \to 0$ as well (specifically $k \propto 1/D^3$). A huge floppy coil is easy to deform, consistent with intuition. Conversely, if D is made very **small** (tight coil) for a given wire, the spring stiffens a lot – in the extreme, a coil diameter approaching zero would be like bending a straight rod, which is very stiff.
- If the number of coils $N \to \infty$ (a very **long spring**), then $k \to 0$. More coils mean the spring can deform more easily (like a long slinky). If N is very small (imagine just 1 coil or fraction thereof), the spring is short and stiffer.
- Higher shear modulus G means a stiffer material: if you somehow made the spring out of an extremely rigid material (say an ideal material with $G \to \infty$), $k \to \infty$ – the

spring would hardly deform at all. (For real materials, G is finite, but materials like steel with high G give higher k than a lower G material like rubber or a polymer.)

- **Use vs. Sibling Equations:** Use this coil spring formula to compute **individual spring stiffness** from geometry. Use the basic Hooke's law $F = k\,\Delta$ to relate force and deflection once you have k. **Do not confuse this with beam deflection formulas or axial bar stiffness** – a coil spring's deformation is due to twisting its wire (torsion), not stretching it like a straight rod. For combining multiple springs, use the **series/parallel spring formulas** to find an equivalent stiffness **before** applying Hooke's law. For example, if two springs support a load together, you'd add their stiffnesses (parallel). If a load goes through one spring then another (one after the other), you'd add their *compliances* (series).

Common Exam Traps:

- **Mixing up d and D:** Don't plug the coil's outer diameter into the formula where the wire diameter goes, or vice versa. Remember d (small) is to the **fourth power**, and D (larger) is cubed in the denominator. Confusing them will throw your result off by orders of magnitude. A quick check: wire diameter is much smaller than coil diameter in a typical spring, and since d is raised to the 4th power, it has a dominant effect on k.
- **Using total coils instead of active coils:** If the spring has coils that don't contribute to deflection (e.g. coils at the ends that are grounded or inactive), the formula requires N = number of **active** coils. The problem may give total coils and specify end conditions – you'll need to adjust N. (See Subtopic 2 on how end conditions affect active coils.)
- **Unit consistency:** The formula as given is dimensionally consistent, but you must use consistent units. If you use SI, ensure G is in Pa (N/m²), d, D in meters, and you'll get k in N/m. If you use US customary, use G in psi, d, D in inches to get k in lbf/in. A common mistake is to plug G in GPa and d, D in mm – that will yield k in mixed units. Convert everything to a single system before computing.
- **Shear modulus vs Young's modulus:** The spring formula uses **shear modulus** G of the material, not the Young's modulus E. For steel, for instance, $E \approx 200$ GPa while $G \approx 80$ GPa. Using E in the formula instead of G would overestimate stiffness. (If needed, recall $G = E/[2(1+\nu)]$ for isotropic materials, but usually G is provided or known.)
- **Calculator entry errors:** Pay attention to parentheses when computing $G\,d^4/(8\,D^3\,N)$. It's wise to break the calculation into parts: compute d^4, compute $8D^3N$ separately, then divide $G \times d^4$ by that denominator. This prevents accidentally doing, say, $Gd^4/8 \times D^3N$ due to a missing parenthesis. On exam-approved calculators, use the ˆ or x^y key carefully, or compute powers stepwise.

Exam Handbook Search Cues (Not affiliated with or endorsed by NCEES): *spring constant; spring rate; spring deflection; Hooke's law* (these terms will help you find the spring formulas quickly in the exam reference).

Explanation & Analysis: The **helical spring constant formula** above tells us how different factors contribute to spring stiffness: it's essentially derived from torsion of the spring's wire. Here's how to interpret it: The wire diameter d is to the fourth power – **even a small increase in wire thickness makes the spring dramatically stiffer** (e.g. doubling d makes k 16 times larger!). Why? A thicker wire resists twisting much more strongly. The coil diameter D appears in the denominator (cubed) – **larger coils are softer** because the wire experiences less twist per unit deflection (a large diameter coil acts like a longer leverage arm, making it easier to bend). If you double the coil diameter, the spring becomes $2^3 = 8$ times less stiff. The number of active coils N is also in the denominator (linearly): more coils means the same deformation is distributed over more segments of wire, so each segment twists less for a given overall deflection – resulting in a lower stiffness. For example, if you cut a spring in half (halving N), you roughly double its stiffness (each half-spring is stiffer). Finally, the shear modulus G scales the stiffness directly – a material twice as rigid in shear will make the spring twice as stiff.

In practical terms, to **use the formula**: First determine the number of active coils N (adjusting for end fixity as needed; see subtopic 2). Make sure all dimensions are in consistent units. Plug into $k = \frac{Gd^4}{8D^3N}$. Once you have k, you can solve any force–deflection problem for that spring. For instance, if a **force** of 500 N is applied to a spring and you found $k = 25000$ N/m, the **deflection** is $\Delta = F/k = 500/25000 = 0.02$ m (2 cm). Conversely, if you need a spring to compress no more than 1 cm under a 1000 N load, you'd set $\Delta = 0.01$ m, $F = 1000$ N and solve $1000 = k(0.01)$ to get the required $k = 100000$ N/m, then use the formula (or experience) to choose geometry/material that provides that stiffness. Remember that **Hooke's law (F = kx)** for springs is linear – in combined systems, springs follow the superposition rules: if two identical springs support a load in parallel, each takes half the load (deflection same) so net stiffness doubles; if they are in series (one after the other), each deflects under the load so deflections add up, making the net stiffness lower (specifically, the reciprocal adds: $1/k_{\text{eq}} = 1/k_1 + 1/k_2 + \ldots$). These series/parallel relations are analogous to resistors in electrical circuits and are worth remembering for exam problems involving multiple springs.

(Footnote: In most FE problems, you won't need to derive this formula – just recall or find it in the handbook. It comes from the torsional deformation of each coil: the wire of length $2\pi D$ per coil twists under the force. The derivation isn't needed on the exam, but understanding it explains why d and D have such strong effects. Also note this formula assumes the spring is homogeneous and coils are not in contact until solid height. *)*

K14.T04.S02 – Spring Geometry & End Conditions (Effects on k and Solid Height)

Principle Introduction:

- Geometry factors: The spring's geometry – wire diameter d, coil diameter D, and number of coils N – has a profound effect on its stiffness. To quickly summarize: **thicker wire, smaller coil diameter, or fewer coils = a stiffer spring.** Thinner wire, larger coil, or more coils = a softer spring. This is directly reflected in the formula from S01: $k \propto \frac{d^4}{D^3N}$. A practical mindset: if you want to make a spring "softer" (lower k), you could use a thinner wire, a larger coil, or add more coils to it. For a "stiffer" spring (higher k), do the opposite – thicker wire, tighter coils, or even shorten the spring (fewer active coils).

- Coil diameter D: Increasing D (making the spring's coils wider) reduces stiffness, because the spring's wire experiences less angular

twist per unit deflection. Decreasing D (tighter coil) makes the spring stiffer but beware practical limits: extremely small D/d ratios lead to high bending stresses in the wire and manufacturing challenges. In standard designs, the **spring index** $C = \frac{D}{d}$ is often in the range of 4 to 12 for a good balance – though you likely won't need to remember specific index values for the FE, just the trend that a *larger* coil index (looser spring) = softer spring, and a *smaller* coil index (tighter spring) = stiffer (but watch for stress).

- **Number of coils N:** Only the active coils contribute to spring deflection. More active coils mean the spring can deform more (longer spring, more stretch per force) so the spring is less stiff. Fewer coils (shorter spring) means each coil carries more of the deformation, so it's stiffer. Think of a long slinky vs a short stiff spring: cutting a spring in half roughly doubles its spring constant. When solving problems, always clarify how many coils are active (the ends might not be active—coming up next).

- **End conditions (active vs inactive coils):** Springs can have different end treatments: **plain ends, squared (closed) ends, ground ends**, etc. These affect how the spring seats and how it deforms: - If a spring has **squared or closed ends**, the end coils are shaped to be flat against a surface. Those end coils typically **do not deform significantly under load** (they mostly touch the supports), effectively making them inactive in terms of spring deflection. Each closed end thus reduces the count of *active* coils. For example, a spring with 10 total coils and both ends closed might have about 8 active coils (2 coils are essentially rigidly supporting the ends). This increases the spring rate k because the spring behaves as if it were shorter (N in the formula is smaller).

- If the ends are **plain (not squared)**, the wire just cuts off at an angle. Plain ends don't sit flat, so the spring might bow or not distribute load evenly initially. However, *all coils can deform* since none are flattened against a support – so the number of active coils N equals the total coils. Plain ends give the maximum N (so lowest k), but they have practical downsides (the spring won't stand straight; often one end will kind of dig in under load). Sometimes one end is plain and the other is seated in a fitting.

- **Ground ends** refer to grinding the end coils flat after they've been squared. Grinding doesn't change the number of active coils (it's usually done in conjunction with closed ends), but it does affect how closely the spring can compress (solid height) and provides a truly flat surface for even load distribution. A **"squared and ground"** spring has both ends closed (inactive) and flat ground – ideal for uniform loading and minimal wobble. A **"plain and ground"** spring would have one end left active and the other end ground flat (so one inactive coil on the ground side, one end active).

- **Solid height L_s:** This is the shortest length the spring can achieve when fully compressed, essentially the height of the spring when all coils are **stacked tightly on top of each other**. At solid height, there is no gap between adjacent coils. Knowing L_s is important for design questions: it tells you the **maximum deflection** the spring can provide (which is $\Delta_{\max} = L_0 - L_s$, where L_0 is the free length). If a problem asks whether a spring can handle a certain compression without "bottoming out," you'll compare the required deflection to $L_0 - L_s$.

Definition Passport – Solid Height L_s

- **Plain-language definition:** *Solid height* (also called *solid length*) is the **length of a spring when it is fully compressed** so that each coil is in contact with adjacent coils. Essentially, it's the thickness of the spring when "squashed flat." For a coil spring, L_s is roughly equal to the wire diameter times the number of coils, plus any extra gap from the end coils if they don't nest perfectly.

- **Where it matters (exam impact):** In spring design problems, solid height lets you know the **maximum deflection** possible. The FE exam might implicitly test this by asking if a given compression is feasible or by giving free length and asking for solid height or vice versa. For example, if free length $L_0 = 100$ mm and solid height $L_s = 50$ mm, the spring can compress at most 50 mm – any more and the coils would bottom out (at which point the spring's rate effectively becomes infinite and it behaves like a solid).

- **Pitfall or confusion point:** Don't confuse *solid height* with *free length*. Free length L_0 is the spring's length in the unloaded state; solid height L_s is much shorter. A common mistake is to assume a spring can always compress further – but **it cannot compress beyond** L_s. Also, be mindful that end conditions affect L_s. Springs with **unground (uneven) ends** often have a slightly larger solid height because the last coil can't press completely flat. Conversely, springs with both ends ground flat achieve a smaller L_s.

- **Micro-check:** True or False? *A coil spring's solid height is equal to its free length minus the deflection at which coils begin to touch.* **(True.)** Once coils start touching, any further compression is just coil-on-coil contact, not elastic deflection. In other words, the maximum elastic deflection = $L_0 - L_s$.

Exam Handbook Search Cues (Not affiliated with or endorsed by NCEES): *spring index; active coils; solid length; free length; spring ends*. (These keywords will help locate reference data on spring geometry and dimensions in the exam handbook if needed.)

Variations and Related Considerations:

- **Active coil count adjustment:** As mentioned, end conditions change the count of active coils. As a rule of thumb: **Closed (squared) ends** usually mean 2 coils (one at each end) are inactive $\Rightarrow N_{\text{active}} = N_{\text{total}} - 2$. **One closed/ground end** means 1 coil inactive $\Rightarrow N_{\text{active}} = N_{\text{total}} - 1$. **Plain ends** (both ends active) $\Rightarrow N_{\text{active}} = N_{\text{total}}$. On the exam, if a problem describes a spring as "squared and ground at both ends" and gives total coils, remember to subtract two coils for your N in the k formula. This detail can easily change your result by 20–30%, so it's a favorite point for exam questions to test.

- **Effect on solid height:** For a spring with **ground ends**, the coils can pack together tightly at solid height. So an approximate formula is $L_s \approx N_{\text{total}} \times d$ (every coil's wire stacks on top of each other). If ends are **not ground** (the end surfaces are not perfectly flat), the spring will have a slightly larger solid height – often approximated as $L_s \approx (N_{\text{total}} + 1)\, d$ (essentially one extra wire diameter to account for the uneven ends). For example, if a spring has 10 total coils of 2 mm wire and both ends ground, $L_s \approx 10 \times 2$ mm $=$ 20 mm. If the same spring's ends were not ground, L_s might be about 22 mm (an extra gap of one wire). In designs, having a smaller solid height is beneficial when space is limited, which is why critical springs are often ground flat.

- **Free length and pre-load:** Free length L_0 is usually given, but sometimes a spring is installed with a **pre-compression** (initial compression) so that even at "no external load" it's partially compressed. The exam might hint at this if, say, a spring is assembled with a certain initial deflection. In such cases, the *active* working deflection range might be from that preloaded length down to L_s. Just be aware in case a question implies an initial compression.

- **Series and parallel springs:** While not exactly geometry, it's related to spring behavior – if you see a setup with multiple springs: - Springs in **series** (stacked one after another or supporting the same load sequentially) will have an equivalent stiffness k_{eq} given by $\frac{1}{k_{\text{eq}}} = \frac{1}{k_1} + \frac{1}{k_2} + \cdots$. The combined spring is softer than either individual spring (it deflects more because each spring contributes to the deflection). - Springs in **parallel** (side by side supporting the same load simultaneously) add their stiffnesses: $k_{\text{eq}} = k_1 + k_2 + \cdots$. The load splits between the springs, so the assembly is stiffer. - The geometry link here: sometimes a "spring" might effectively be two springs in one (like a concentric spring or a multi-leaf spring can be modeled as parallel springs). Be ready to use those formulas if needed.

- **Typical values and design limits:** Most FE problems won't require memorizing numbers, but it helps to have a sense: Spring wire diameters might range from <1 mm in small springs to >25 mm in heavy springs. Coil counts commonly 5–15 in many springs. If you calculate a weirdly large or tiny k, double-check inputs. For instance, a pen spring might have $k \sim 5$ N/m, whereas a car suspension spring might be $k \sim 20{,}000$ N/m. If your computation for a small spring yields $k = 10^6$ N/m, that's likely off by a unit conversion. Use reasonable intuition as a check on exam answers.

Special Notes: When entering spring geometry into your calculator, pay attention to scientific notation and groupings. For example, with a very large G (say 77×10^9 Pa) and small d, the numerator Gd^4 might be a huge or tiny number – ensure you input it correctly. It can be handy to calculate d^4 by successive multiplication (e.g., d^2 then square again) to minimize rounding error. Also, **spring problems often combine units** (e.g., force in lbf and length in inches for k in lbf/in). Keep track of units throughout; consider converting to one system at the start. Finally, remember that once coils begin to touch (approaching solid height), the spring's behavior is no longer linear – but exam questions will usually avoid that range or specifically mention it. If you ever get a result that would require compressing beyond solid height, that's a red flag that either the scenario is impossible or you need to re-check the assumptions.

Explanation & Analysis: Changing a spring's geometry is the primary way engineers design springs for desired stiffness. Let's break down each factor: **Wire diameter** d – because k grows with d^4, even a modest increase in wire thickness makes a huge difference. Imagine two springs identical except one uses a thicker wire: it's much harder to twist that thicker wire, so the spring resists deformation more. **Coil diameter** D – a larger coil acts like a longer wrench turning the wire (the wire experiences less twist for the same overall compression). So a big loose coil is like a floppy Slinky: easy to compress. A small tight coil is like trying to bend a short rod: much harder. **Number of coils** N – if you stretch a spring out to have more coils (longer spring), each coil shares the load, and the spring as a whole is more compliant. Fewer coils concentrate the deformation, making it stiffer (short spring). It's analogous to having multiple segments of a spring vs a single segment – multiple segments (coils) divide the deflection. This is why cutting a spring makes it stiffer, and why, conversely, if a spring breaks and you lose a coil, the remaining spring gets stiffer.

End conditions add an extra layer: when a coil is "inactive," it means that coil isn't freely deflecting – usually because it's in contact or constrained. A **closed and ground end** essentially anchors that end of the spring: the last coil is flat against a surface and doesn't really twist; it just provides a flat footing. Thus, you lose a bit of spring length in terms of active deflection, but you gain stability and a smaller gap at the end. If both ends are closed and ground, two coils aren't participating in the spring's elasticity (one at each end). The **effect on** k is that the spring behaves as if it had $N - 2$ coils: stiffer than if those end coils were active. On the other hand, **plain ends** leave all coils active, but the trade-off is the spring might not load as evenly. From a problem-solving perspective, the key is: *use the correct* N. The problem will often hint at this by specifying the spring type. For instance, "a spring has 12 total coils with plain ends" – you'd take $N = 12$ in the formula. If it said "12 total coils, squared and ground ends," you'd use $N = 10$ active. This can change your answer significantly, so double-check the end conditions. A quick mental check: a spring with ground ends will be a bit stiffer (fewer active coils) than the same spring with plain ends, all else equal. If your calculation doesn't reflect that when it should, revisit how you set N.

Now, **solid height** L_s and related deflections: The spring can compress until basically it turns into a solid stack of wire. At that point, any further attempt to compress is like trying to compress a steel rod (which you can't, practically). Thus, L_s is a hard limit. If a problem gives you free length and asks for maximum deflection, subtracting L_s is the way. For instance, a spring with free length 4 inches and solid height 3 inches can only compress 1 inch max. If asked "will the spring be solid under the given load?", you'd find the deflection from $F = kx$; if the required x exceeds 1 inch in this example, the spring would reach solid height before taking that load – meaning the assumptions of Hooke's law break down at that point. So the exam could indirectly test you by giving a scenario that demands more deflection than possible; the correct conclusion would be that the spring would bottom out (and maybe you'd instead calculate the load at which it goes solid). Always compare the needed deflection to $L_0 - L_s$ if such details are given or can be deduced.

In summary, pay attention to the geometry inputs in spring problems: if you see a variable change like "the wire diameter is increased by 20%," expect a big change in k (specifically 20% increase in d -> 107% increase in k, since $1.2^4 \approx 2.07$). If the coil diameter is increased by 20%, k will drop (roughly $1/(1.2^3) \approx 0.58$, a 42% drop). These proportional reasoning shortcuts can sometimes save calculation time or catch errors. And always confirm the number of active coils: a quick way is to recall the typical end adjustments (0, 1, or 2 inactive coils depending on ends). With these insights, you'll handle spring questions with confidence – compressing those problems to solid answers without getting sprung by tricky details!

Topic 05 - Pressure Vessels and Piping

Topic Introduction: Pressure vessels and pipes are ubiquitous in mechanical systems—think of boilers, gas cylinders, or even the pipes in a hydraulic circuit. On the FE Mechanical Exam, you'll often face questions about the stresses induced by internal fluid pressure in these components. Why does it matter? If a vessel's wall is too thin for a given pressure, it can **burst** (hoop stress failure) or **split** at the seams. The exam typically asks you to compute either the stress in a thin-walled vessel (to check if it stays below a material's yield strength) or the required wall thickness for safe operation. The archetypal problems involve a cylindrical tank or spherical container under internal pressure, where you must apply the **thin-walled pressure vessel formulas** to find hoop stress, longitudinal stress, or compare a sphere versus a cylinder. By mastering this topic, you'll be equipped to quickly identify the right formula and avoid common pitfalls (like mixing up radius and diameter, or hoop vs. longitudinal stress). In short: this topic is about keeping pressure-containing equipment safe by **getting the stress calculations right** – a fundamental skill for any mechanical engineer. Let's dive in.

K14.T05.S01 – Thin-Walled Cylindrical Vessels (Hoop & Longitudinal Stress)

Principle Introduction:

- A thin-walled cylindrical pressure vessel (imagine a long pipe or tank with capped ends) under internal pressure develops **tensile stresses** in its walls. These stresses try to rip the cylinder open.
- There are two primary normal stresses in a closed cylinder: **hoop stress** (also called circumferential stress, acting around the circumference) and **longitudinal stress** (acting along the length, also called axial stress). Both are due to the internal pressure p pushing outward.
- **Hoop stress** is the tension that would split the cylinder along its length (like slicing it open longitudinally). **Longitudinal stress** is the tension that would rip the end caps off (it runs along the vessel, resisting the pressure on the end caps).
- For a **thin-walled** cylinder (wall thickness t is small relative to the radius r), these stresses are assumed uniform across the wall thickness. Thin-wall theory usually means $t \leq \frac{1}{10} r$ (about 10% or less of the radius) – under this condition, variations of stress through the wall are negligible and the formulas are simplified.
- Importantly, **hoop stress is twice as large as longitudinal stress** in a cylindrical vessel with closed ends (for the same p, r, t). This 2× difference comes from geometry: the circular hoop has to hold in pressure over a larger area (the sides of the cylinder) whereas the longitudinal direction "only" holds the pressure on the end caps. In practical terms, a cylinder's wall is more critically loaded in the hoop direction than in the axial direction, which is why design codes often focus on hoop stress for thickness calculations.

Exam Handbook Search Cues (Not affiliated with or endorsed by NCEES): *thin-walled cylinder*, *hoop stress*, *longitudinal stress*, *axial stress*, *cylindrical pressure vessel* (These are keywords you'd use to find these formulas in the exam reference.)

Footnotes:

- *Thin-wall criterion:* These formulas assume t is **much smaller** than r (commonly $t \lesssim 0.1\, r$). If the wall is thicker, the stress isn't uniform and you'd need more advanced analysis (thick-wall formulas) not typically required on the FE exam.
- *Closed ends required:* The **longitudinal stress** formula assumes the cylinder has end caps (pressure acting on circular ends). If a pipe is open at the ends (no sealed end caps), internal pressure doesn't create axial tension in the pipe wall[^1].
- *Gauge pressure:* Use the **pressure difference** between inside and outside. Usually problems give internal gauge pressure (pressure above atmospheric). If they give absolute pressure, remember to subtract the outside pressure (often atmospheric) – it's the difference that drives stress.
- *Radius vs. diameter:* The formulas use **radius** r, not diameter. It's a common mistake to plug in the diameter where r is required – doing so will double your stress value by accident. If a problem gives diameter D, note that $r = D/2$. (You can rewrite the hoop stress formula as $\sigma_{hoop} = \frac{pD}{2t}$ to directly use diameter if that's easier for you.)
- *Units watch:* Ensure consistent units. If p is in Pa (N/m²) and r, t in meters, σ comes out in Pascals (which can be converted to, say, MPa by dividing by 10^6). If p is given in psi and dimensions in inches, σ will be in psi. Don't mix unit systems in the formula – convert first, or use the same unit family throughout.

Variations, Related Forms, Typical Values:

- The hoop and longitudinal stress formulas are sometimes referred to as **"membrane stress"** formulas for thin shells. They are a special case of the general pressure vessel stress equations when the wall is thin. No complex bending or radial stress distribution is considered here.
- If you solve for thickness, the hoop formula can be rearranged as $t = \frac{pr}{\sigma_{allow}}$ (or with a safety factor included in the allowable stress). This is how you'd **size a pressure vessel's thickness** given a material strength and a desired pressure. Longitudinal would give $t = \frac{pr}{2\,\sigma_{allow}}$, but since hoop is the larger stress, it usually controls design.
- **Spherical vs. Cylindrical:** For the same radius and internal pressure, a spherical vessel needs only half the wall thickness of a cylinder (because the sphere's stress is lower – see next subtopic). This is why spheres are used for very high-pressure storage when possible: the stress is distributed more evenly. Cylinders, however, are often more practical to manufacture and use, despite needing thicker walls for the same pressure.
- **Typical magnitudes:** In real applications, hoop stresses can be quite high. For example, a cylindrical boiler at 2 MPa (about 290 psi) with a 1 m radius and 10 mm wall thickness sees $\sigma_{hoop} = \frac{2\times10^6\times1}{0.01} = 200 \times 10^6\text{Pa} =$

200 MPa of hoop stress – which is on the order of high-strength steel's yield stress. This tells us why pressure vessels are often thick and made of strong materials (and why we never underestimate these stresses!). On the exam, numbers will be chosen to be reasonable; always double-check that your answer makes physical sense (e.g. it shouldn't exceed material strengths by absurd amounts).

- **Thick-walled cases:** If t is not negligible compared to r, the stress varies across the thickness (hoop stress is higher at the inner wall than outer). The exam **won't require** deriving or memorizing thick-wall formulas, but be aware: the thin-wall formulas **overestimate the strength** if used on a thick wall (they give a lower stress than actual at the inner surface). So only use thin-wall equations when appropriate.

Special Notes (Calculator Usage): These stress equations are straightforward linear formulas. All exam-approved calculators can handle them easily – just be careful with the division by 2 for the longitudinal stress. For example, to avoid ambiguity, it's better to compute σ_{long} as p * r / (2 * t) so the calculator knows that $2t$ is the whole denominator. Likewise, ensure you input any scientific notation for p or dimensions correctly (e.g. 2e6 for 2×10^6 Pa). A quick unit sanity check before finalizing your answer is recommended (especially if you had to convert units).

Explanation & Analysis (Step-by-Step): Why do these formulas look the way they do, and how do we use them? Let's break it down: Imagine a cylindrical pressure vessel with internal pressure p. That pressure is pushing outward on every part of the wall. To find the resulting stress, we apply equilibrium: **cut the vessel** and balance forces. For **hoop stress**, cut the cylinder with a vertical plane through its axis, splitting it into two halves (like cutting a water tank lengthwise). Now consider one half: the internal pressure is pushing outward on that half-cylinder, trying to make it bulge. The only thing holding it together is the tension in the curved wall (the hoop stress acting along the cut edges). By balancing the force from pressure to the force from stress in the wall, we get $\sigma_{\text{hoop}} = \frac{p\,r}{t}$.

- In this formula, p is the internal pressure (typically in Pascals or psi). Use the gauge pressure – if the outside is at atmospheric pressure, p would effectively be the amount above atmospheric outside. This term shows that higher internal pressure obviously means higher stress.
- r is the **radius** of the cylinder (usually the *inner* radius, in meters or inches). A larger radius means a larger hoop stress, because a bigger cylinder has more *area* for the pressure to act on, putting more load on each unit width of the wall. (Think of a bigger "loop" of material being stretched by the pressure.) For thin-wall cases, sometimes we use the average radius $r \approx \frac{r_i + r_o}{2}$, but since t is small, r_i (inner) or r in general is fine. Just be consistent – if you use inner radius, that's standard for these formulas.
- t is the wall **thickness** (in the same units as r). The thinner the wall, the less cross-sectional area of material we have to carry the internal force, so thinner t gives higher stress. In the formula, t is in the denominator, so as t decreases, σ increases – that matches our intuition (a soda can with ultra-thin walls will burst under even modest pressure).
- The resulting σ_{hoop} is a **tensile normal stress** in the material (units of Pa or psi, same as pressure but scaled by the r/t ratio). This stress acts **along the circumference** of the cylinder. It's one of the principal stresses in the wall (assuming no other loads, the other principal stress is the longitudinal, and there's a minor radial stress). On exam day, you might be asked for the magnitude of this stress, or perhaps asked conceptually which stress (hoop vs. longitudinal) is larger – and now you know hoop is the bigger one for a cylinder.

For **longitudinal (axial) stress**, we do a similar thought experiment: cut the cylinder across its cross-section (imagine slicing off the end cap of a pressure tank). The pressure is pushing the end cap outward. What holds the end cap from flying off? The cylinder's wall, which is in tension around the circumference of that circle (like a band securing a drum lid). The force from pressure on the end cap (which is $p \times$ Area of the end cap, $= p\pi r^2$) is resisted by the **axial stress** in the walls (acting over the cross-sectional area of the wall material around the rim, which is the circumference $2\pi r$ times thickness t). Setting pressure force equal to stress force gives $\sigma_{\text{long}} = \frac{p\,r}{2t}$. Notice the 2 in the denominator – mathematically it comes from the geometry (the circumference times thickness provides twice the area compared to the scenario for hoop, effectively). Physically, you can think of it this way: the cylindrical wall provides a **hoop of material around the edge of the end cap**, and that hoop shares the load in two directions (top and bottom of the circle, or left and right, etc.), whereas in the longitudinal cut case for hoop stress, the wall was only split into two halves carrying the load. In any case, the axial stress is half the hoop stress for the same p, r, t.

- σ_{long} is the **tensile stress along the axis** of the cylinder's wall (imagine the wall being pulled taught in the vertical direction for a horizontal cylinder, or along the length for a standing cylinder). It has the same units and similar dependencies as hoop stress – proportional to p and r, and inversely proportional to t.
- Because of the factor of 2, if you mistakenly forget it, you'd overestimate axial stress. Always remember: **a closed cylinder's wall sees half the stress in the axial direction as it does in the hoop direction** under internal pressure. The end caps "feel" easier to hold on than the split along the side. If you ever get confused, derive it with a quick force balance as above – it's straightforward and a good sanity check.
- Also note: if the question involved a **long pipe with open ends** (not a common scenario for pressure vessels, but just to think it through), there would be no pressure force trying to pull the pipe apart lengthwise (since the fluid just pushes out of the ends freely). In that case, σ_{long} would be essentially zero – and indeed our formula would not apply because one of its key assumptions (closed ends) is violated. The hoop stress, however, would still apply to the pipe wall as it resists circumferential expansion.

Finally, keep an eye on units and known values: If a result for stress comes out oddly high or low, double-check r vs. diameter and unit conversions. For instance, mixing up mm and m (a factor of 1000) in thickness or radius will throw the result off by a factor of 1000 – a common mistake under time pressure. A quick mental check: does the number make sense for typical material strengths? (Steel yields around 250 MPa, so if your computed σ is 2500 MPa for a moderate pressure, something's off!). By systematically applying these formulas and being mindful of these details, you'll

confidently handle any thin-walled pressure vessel question on the FE exam.

K14.T05.S02 – Thin-Walled Spherical Vessels (Uniform Membrane Stress)

Principle Introduction:

- A **spherical pressure vessel** (like a round pressure tank or a spherical gas storage container) has a single uniform stress under internal pressure. Because of symmetry, any cut through the sphere experiences the same stress in the shell.
- **Thin-walled sphere:** If the shell thickness t is small relative to the sphere radius r, the stress is uniform through the thickness (same thin-wall assumption as before). All directions in the plane of the shell are equivalent (no distinct "hoop" vs. "axial" directions like in a cylinder – a sphere has **no ends**).
- The tensile stress in a spherical shell due to internal pressure is often called **membrane stress** or just **circumferential stress**, and it acts everywhere in all directions along the surface. Essentially, the sphere's wall is being pulled taut uniformly, like an inflating balloon's rubber skin where the tension is the same no matter where you look.
- **Key result:** The formula for a thin-walled sphere under internal pressure is $\sigma = \frac{p\,r}{2\,t}$. This is *half* the magnitude of the hoop stress in a cylinder (for the same p, r, t). In other words, a sphere is a more efficient container for pressure – its stress is lower because the load is shared in two dimensions uniformly.
- This single formula $\sigma = pr/(2t)$ applies for **all directions** on the spherical shell (any meridian or latitude you cut along). On the exam, if they describe a "spherical pressure vessel" or a "thin-walled sphere," you should immediately think of this simpler case where there's just one stress to compute (and it's easier to hold pressure than a cylinder, stress-wise).

Exam Handbook Search Cues (Not affiliated with or endorsed by NCEES): *thin-walled sphere*, *spherical vessel stress*, *uniform membrane stress*, *pressure vessel (sphere)* (Use these keywords in the exam reference to locate the spherical vessel stress formula or related info.)

Footnotes:

- *One stress state:* Unlike a cylinder, a sphere doesn't have two different stress values – **every direction in the plane of the sphere's wall is the same**. The term "hoop stress" can be used for a sphere too (since any circle drawn on the sphere's surface acts like a hoop), but don't let that confuse you: it's not a different value in another direction; it's the *same* $\sigma = pr/(2t)$ everywhere.
- *Derivation insight:* If you're curious where the "2" comes from here: imagine cutting the sphere into two halves. The pressure force trying to separate the halves is $F = p \times (\text{area of great circle}) = p\pi r^2$. The area of metal resisting this (the "rim" of the cut, which is a circle) has a circumference $2\pi r$ and thickness t. Multiply $2\pi r \times t$ to get the cross-sectional area of that ring of metal. The stress times area equals force: $\sigma \cdot (2\pi r t) = p\pi r^2$. Solve for σ: you get $\sigma = \frac{p\pi r^2}{2\pi r t} = \frac{pr}{2t}$. It's the same equilibrium logic as the cylinder, just applied to a different geometry.
- *Thin-wall requirement:* Use this formula when t is much smaller than r (just like for cylinders). If the sphere's wall is thick, stresses would vary through thickness and you'd need more complex analysis (likely beyond FE exam scope).
- *Absolute vs. gauge:* As with cylinders, use gauge pressure (internal minus external). If a sphere is storing vacuum (external pressure higher than internal), p would be negative in the formula (yielding a negative stress meaning compression in the wall). Usually exam questions stick to positive internal pressure causing tension.

Variations, Related Forms, Typical Values:

- If given diameter D of a sphere, you can express the stress as $\sigma = \frac{pD}{4t}$ (since $r = D/2$). This is a handy variant if a problem supplies diameter directly. Be careful: many remember the cylindrical formula $\sigma_{hoop} = pD/(2t)$ and might misapply it to a sphere – the sphere's factor is $1/4$ with D because of the extra 2 in the denominator.
- In comparison to a cylinder: for the *same* pressure and wall thickness, a sphere with radius r experiences half the stress a cylinder of radius r does. Equivalently, to withstand a given pressure at the same stress level, a spherical vessel can have half the thickness of a cylindrical vessel. This is why high-pressure gas storage often uses spherical tanks (or end caps of cylindrical tanks are often hemispherical to reduce stress).
- Real-world note: Spherical vessels are structurally ideal but can be impractical for storage (they don't stack or transport as easily). That's why many tanks are cylindrical with domed ends (a compromise). On the exam, if you encounter a spherical vessel problem, rejoice – it's usually a straightforward plug-and-solve with $\sigma = pr/(2t)$, with less chance for mix-ups since there's only one stress to find.
- **Typical values:** Suppose you have a spherical tank of radius 0.5 m (~1.6 ft) with internal pressure 1 MPa (~145 psi) and wall thickness 5 mm. The stress would be $\sigma = \frac{1\times10^6\times0.5}{2\times0.005} = 50\times10^6$ Pa $= 50$ MPa. That's a moderate stress well within range for steel (which might have yield around 250 MPa). If the same pressure and thickness were applied to a cylinder of $r = 0.5$ m, the hoop stress would be 100 MPa – twice as high. This numerical perspective reinforces how much more **pressure-friendly** spheres are.
- **Buckling vs. yielding:** One variation to be mindful of (though likely not tested deeply on the FE) is that when thin shells are under **external pressure** (like a submarine hull being pressed in by water, or a vacuum sphere), failure often happens by *buckling* (collapse) before the material's compressive strength is reached. The thin-wall formulas we've given are for internal pressure (tension in the walls). External pressure scenarios use different criteria (critical buckling pressure) and are usually not asked on the FE Mechanical – but it's good to remember that thin shells have that separate mode of failure.

Special Notes (Calculator Usage): The spherical stress formula is even simpler than the cylindrical case – it's a single calculation. Just be mindful to include the division by 2. For example, if using a calculator, $\sigma = pr/(2t)$ should be entered as (p * r) / (2 * t) to be clear. If you use the variant with diameter, $\backslash sigma = p\ D\ /$

$(4\ t)$`, enter it exactly as such. Because these operations are straightforward, calculator errors are uncommon here; the more likely mistakes are conceptual (using the wrong formula or values). So focus your attention on setting up the formula correctly – the calculator will handle the arithmetic just fine.

Explanation & Analysis (Step-by-Step): In a spherical vessel, the beauty is that we don't have to distinguish between hoop and longitudinal directions. Consider a thin-walled sphere (like a hollow ball) under internal pressure p. **Take any great circle cut** (imagine slicing the sphere into two hemispheres). The internal pressure is pushing the two halves apart. The only thing keeping them together is the tension in the sphere's wall along that cut. Because the sphere is symmetric, it doesn't matter where you cut it – you get the same scenario and the same stress requirement. From the force balance derived in the footnote: the pressure force on the circular cut ($p\pi r^2$) is carried by the tension in the wall along the cut circumference ($\sigma \times 2\pi r t$). Setting them equal yields $\sigma = \frac{pr}{2t}$.

Let's interpret this result:

- p = internal pressure (Pa or psi, gauge). Higher internal pressure → higher stress, directly proportional. No surprise there.
- r = sphere radius (m or in). A larger sphere has more surface area for pressure to act on, which increases the total force trying to pull the sphere apart. The stress is proportional to r. This means big spherical tanks **need thicker walls** than small spherical tanks for the same pressure and material strength. (Think of blowing a small soap bubble vs. a giant bubble – the bigger one is more likely to burst under the same internal pressure because the film stress is higher.)
- t = wall thickness (m or in). Thicker walls reduce the stress (inverse relationship). If you double the thickness, the stress halves. This matches our intuition: a thicker shell can carry more load.
- The factor of 2 in the denominator indicates the load is shared in two directions (the sphere's curvature spreads the force). This is why the sphere has lower stress than a cylinder: the sphere is effectively "stronger" for containing pressure because every part of the wall supports every direction – there are no weak points like a cylinder's longitudinal seams.
- The calculated σ is the **tensile membrane stress** in the spherical shell (units Pa or psi). If you were designing the sphere, you'd ensure this σ stays below your material's yield stress (with some safety factor). On the exam, you might be asked simply to compute this stress, or compare it to a material limit, or perhaps find t given allowable stress. The procedure is straightforward because there's just the one formula.

One common application: If a question gives you both a cylindrical and a spherical vessel and asks which one experiences higher stress under the same conditions – you can confidently say the cylinder (specifically its hoop stress) is higher, by a factor of 2. If they ask for a numeric value, plug in the numbers to $\sigma_{\text{cyl, hoop}} = \frac{pr}{t}$ versus $\sigma_{\text{sph}} = \frac{pr}{2t}$, or simply note the ratio $\sigma_{\text{cyl, hoop}}/\sigma_{\text{sph}} = 2$. Just be careful to use the right formula for each shape.

In all calculations, maintain unit consistency and double-check if the problem is giving diameter or radius, gauge or absolute pressure. The thin-walled sphere formula is one of the simpler ones you'll use on the FE, so it's a prime candidate for quick mental math checks too. For instance, if p is zero, clearly σ should be zero (makes sense – no pressure, no stress). If t is extremely thin, the formula suggests σ will be huge – which is a red flag to any engineer that a very thin sphere can't hold pressure (and in reality might yield or burst). If r is extremely small (like a tiny sphere), σ goes down – indeed small pressure capsules can hold pressure more easily (think of how a small diameter tube can handle higher pressure than a large diameter pipe of the same thickness). These qualitative checks can be handy if you need to eliminate unreasonable answer choices.

Bottom line: for pressure vessels on the FE Exam, memorize (and understand) these core thin-wall formulas. When faced with a problem, identify the vessel shape (cylindrical or spherical), identify what's being asked (hoop stress? longitudinal stress? required thickness?), and apply the appropriate formula confidently. You now have a structured "passport" to navigate these questions efficiently – keeping your units straight, your factors of 2 in place, and your engineering judgment on hand. Good luck, and remember that mastering these fundamentals is one step closer to becoming a licensed professional (and making sure all those real-world pressure tanks stay safe!).

Topic 06 - Bearings

Topic Introduction: Bearings are machine elements that support rotating shafts and reduce friction between moving parts. In mechanical design, "bearings" usually refers to rolling contact bearings (ball or roller bearings) which use balls or rollers to carry loads with minimal friction. This topic matters on the FE Mechanical Exam because many rotating machinery problems involve ensuring a bearing will last a required amount of time under load. Typical exam questions ask you to either **calculate the expected fatigue life** of a bearing given its load rating and the applied load, or **select an appropriate bearing** (with a sufficient load rating) to achieve a desired life at a given load and speed. The core principle you'll use is a fatigue life equation that relates bearing load to life, along with basic considerations of reliability and units.

K14.T06.S01 – Bearing Life Analysis

- Rolling element bearings (ball and roller bearings) have a finite fatigue life due to repeated stress cycles in their raceways.
- Bearing "life" is defined statistically. The basic rating life, L_{10}, is the life—measured in revolutions (or in operating hours at a given speed)—that 90% of a group of identical bearings are expected to reach or exceed under a specified constant load (so only 10% would fail earlier).
- Manufacturers specify a **dynamic load rating C**, defined as the constant radial load that corresponds to an L_{10}life of 1×10^6revolutions. In other words, if a bearing is loaded at exactly its rated capacity C, it has an expected L_{10} life of 1 million revolutions.
- The bearing fatigue life **increases dramatically as the applied load is reduced**. The relationship is highly nonlinear: a slight decrease in load can yield a much longer life.
- **Exam tip:** For the FE Exam, you'll usually assume steady operating conditions (constant load, proper lubrication, no shock loads) and use the standard life formula for ball or roller bearings. Always interpret "life" in terms of either revolutions or hours as specified, and remember that L_{10} uses the 90% reliability criterion by default.

Equation Passport – Basic Rating Life (L_{10}): Calculates the expected fatigue life of a rolling bearing under a constant load, in terms of millions of revolutions (can be converted to hours if rotational speed is known).

Equation:

$$L_{10} = \left(\frac{C}{P}\right)^a$$

where a is an exponent that depends on bearing type.

Variables and units:

- L_{10} – basic rating life (in **millions of revolutions** of operation).
- C – basic dynamic load rating of the bearing (same force units as P; e.g. Newtons or pounds-force).
- P – equivalent steady load on the bearing (same units as C; typically the radial load, in N or lbf).
- a – life exponent (dimensionless: $a = 3$ for ball bearings, $a = 10/3 \approx 3.33$ for roller bearings).

Assumptions and scope:

- Applies to rolling-contact bearings under **constant load and speed**, with proper lubrication and alignment.
- L_{10} is a **90% reliability life** (only 10% of bearings are expected to fail by that point; 90% survive longer).
- Valid for standard bearing materials and normal operating conditions – extreme temperatures, vibrations, or lubrication failures are outside this basic formula's scope.
- The load P should be the constant **equivalent radial load**. (If there's a significant axial (thrust) load, convert it to an equivalent radial load using manufacturer factors X, Y before using this formula.)

Limit tests (sanity checks):

- If $P = C$: then $L_{10} = 1$. Loading a bearing at its exact dynamic rating gives about **1 million revolutions** of life by definition (baseline case).
- If $P \ll C$: (load is much smaller than rating), L_{10} becomes very large – a lightly loaded bearing can last effectively "infinite" revolutions (in practice, other factors like lubrication tend to wear out first).
- If $P \gg C$: then L_{10} becomes very small – heavy overloads can destroy a bearing in far fewer cycles than the reference 1 million rev (avoid designing in this regime).

Use vs. sibling equations: Use this fatigue life equation for **rolling bearings** when you have the dynamic load rating. *Do not confuse it with equations for static load capacity or for other types of bearings.* (Plain journal bearings, for example, use hydrodynamic lubrication theory instead of an L_{10} life formula.)

Common exam traps:

- **Unit mix-ups:** C and P must be in the same units (don't mix SI and USCS). If C is given in kN and P in N, convert one so both are consistent.
- **Misinterpreting L_{10}:** Remember L_{10} is in millions of revolutions. If $L_{10} = 5$ from the formula, that means 5,000,000 revolutions. You might need to convert that into hours depending on the RPM.
- **Wrong exponent:** Make sure to use $a = 3$ for ball bearings and $a = 3.33$ for roller bearings. Using the wrong exponent (or forgetting to raise the ratio to the power at all) will give the wrong life.
- **Reliability confusion:** Don't assume L_{10} means all bearings last that long. It's a statistical measure. The exam likely won't dig into this nuance, but remember that median life (50% of bearings failing) is higher than L_{10}. Stick to L_{10} unless told otherwise.

Exam Handbook Search Cues (Not affiliated with or endorsed by NCEES): *bearings*, *basic load rating*, *bearing life*, *dynamic load rating*, *L10*

Units: The standard life formula is unit-consistent: if C and P are in pounds-force, the calculated L_{10} is valid (dimensionless, representing millions of cycles). Same idea if using N. Just avoid mixing units or interpreting L_{10} as million hours by accident.
Reliability: "Basic rating life" L_{10} always implies 90% reliability. If a problem ever specifies a different reliability level (rare in FE exam context), an adjustment factor or different approach would be needed (usually not required on the FE).
Exponent notation: Some sources use the letter **e** for the life exponent (e.g. $L_{10} \propto (C/P)^e$). On the exam, stick to a to avoid confusing the exponent with the mathematical constant e.
Bearing types: The formula covers ball and roller bearings. It does **not** apply to sliding bearings (bushings) since those do not have a fatigue life defined by C and a.

Variations and related forms:

- **Life in hours:** You can convert life in revolutions to life in hours. If L_{10} is, say, 5 (million revolutions) and the shaft rotates at N RPM, then total revolutions to failure = 5×10^6. The hours of operation would be
  Life (hours) $= \frac{5\times10^6 \text{ rev}}{N \text{ rev/min}\times60 \text{ min/hour}}$.
  In general, Life (hours) $= \frac{L_{10}\times10^6}{60\,N}$. Higher speed (larger N) means those cycles are used up sooner (fewer hours for the same number of revolutions).
- **Example – load effect:** Because of the exponent, reducing load significantly boosts life. *For example, if a ball bearing is loaded at half its rated load ($P = 0.5\,C$), then $L_{10} = \left(C/(0.5C)\right)^3 = 2^3 = 8$. That's 8 million revolutions of life, versus 1 million at the full rating.* This dramatic increase shows why engineers prefer to operate bearings well below C for longevity.
- **L50 life (FYI):** Although not typically needed for the FE exam, note that the median life (50% of bearings failing) is much higher than L10. Roughly, L_{50} is about 4–5 times L_{10} for ball bearings. The exam will stick to L_{10}.

Special notes – calculator usage: When raising a ratio to a power, especially a fractional power (like 10/3 for roller bearings), use parentheses on your calculator. For example, to compute $(C/P)^{10/3}$, on a TI-36X Pro or Casio fx-991 you might type (C ÷ P) ^ (10/3). All NCEES-approved calculators can handle fractional exponents, but ensure you enclose the fraction in parentheses so the calculator interprets it correctly.

Explanation & Analysis: The basic rating life formula is essentially a **fatigue failure model** for bearings. It tells you how long a bearing can roll under a certain load before material fatigue causes failure (pitting or spalling of the raceway). The key insight is that **load is the dominant factor** in fatigue life: bearings under lighter loads last exponentially longer than those under heavy loads.

Let's break down the equation $L_{10} = (C/P)^a$ term by term:

- C (dynamic load rating) is a property of the bearing, determined by its size, material, and construction. It's the load that would give a baseline life of 1,000,000 revolutions. A higher C means a more robust bearing that can handle larger loads for the same life.
- P is the actual load the bearing experiences in service (after combining any radial and axial components into an equivalent single load). This is the load we, as engineers or exam-takers, plug into the formula based on the problem statement.
- The ratio C/P tells us how "hard" the bearing is working relative to its capacity. If $C/P = 1$, the load equals the rating and the bearing will last about the reference life (1 million rev). If $C/P > 1$, the load is smaller than the bearing's capacity, so the bearing should last longer than 1 million rev. If $C/P < 1$, the bearing is overloaded relative to its design rating, and its life will be shorter (in design, you avoid $C/P < 1$ because it implies an undersized bearing).
- The exponent a (3 for ball bearings, 3.33 for rollers) indicates how sharply life responds to load changes. For ball bearings, life is inversely proportional to the cube of load. This means even modest reductions in load produce large increases in life: a **cube-law** relationship. Roller bearings have $a \approx 3.33$, making them even a bit more sensitive to load (life changes slightly more steeply with load).

These exponents come from decades of testing and empirical curve-fitting. You don't need to derive a; just remember the standard values and that they reflect fatigue behavior of different contact geometries (point contact for balls vs line contact for rollers).

Using the formula on the exam: If a problem gives you C and P, computing L_{10} is straightforward: plug in the numbers and raise (C/P) to the power a. Always double-check units first (e.g. if given kN, convert to N, or ensure consistency).

After finding L_{10} (which might come out as a number like 2.5 or 7.8), interpret it properly:

- If the question asks for life in **number of revolutions**, multiply L_{10} by 1,000,000. For example, if $L_{10} = 2.5$, that means 2.5×10^6 revolutions.
- If it asks for life in **hours**, you need the rotational speed to convert cycles to time. Suppose the bearing runs at 1800 RPM continuously. Then 2.5 million revolutions correspond to
  $$\frac{2.5 \times 10^6 \text{ rev}}{1800 \text{ rev/min} \times 60 \text{ min/hour}} \approx 23.1 \text{ hours}$$
  Always divide the total revolutions by ($RPM \times 60$) to get hours.

One common mistake is to plug hours directly into the life formula without conversion. For instance, do **not** plug 5 (hours) into L_{10}. The formula expects a dimensionless life count in millions of rev. You must convert hours to the equivalent number of revolutions first.

Finally, keep in mind why this matters: we want to ensure bearings last through the intended service life of the machine. If an exam problem gives a required life, you might have to work backwards – that's where the selection formula comes in.

K14.T06.S02 – Bearing Selection Considerations

- **Sizing a bearing for longevity:** If you need a bearing to last a certain number of hours or years under a given load, you must ensure its dynamic load rating C is high

enough. Essentially, you invert the life formula to solve for the required C.

- The minimum required C grows as the desired life or the working load increases. Higher required life L_{10} or higher load P both demand a bearing with a higher load rating.
- Rotational speed itself does not directly appear in the life equation (which is based on number of revolutions), but **speed affects the conversion from cycles to time**. A high RPM means a given number of revolutions elapse faster (fewer hours to reach the same number of cycles). So, for a fixed desired life in hours, a higher speed implies a greater required life in rev, and thus a larger C.
- Manufacturers provide catalogs where each bearing's C is listed. As an engineer or exam-taker, you calculate the minimum C needed and then **select a bearing** whose rating meets or exceeds that value.
- Other practical considerations (usually not tested explicitly on the FE) include bearing type (ball vs roller vs others), lubrication quality, and dynamic factors for varying loads. For exam purposes, focus on the fatigue life requirement and using the formula correctly for selection.

Equation Passport – Required Dynamic Load Rating: This is the rearranged bearing life equation, solving for C. It gives the **minimum basic load rating** a bearing must have to achieve a specified life under a given load.

Equation:

$$C_{\min} = P\,(L_{\text{desired}})^{\frac{1}{a}}$$

where L_{desired} is the target life in millions of revolutions.

Variables and units:

- $C_{\min}$ – required basic dynamic load rating (force units, e.g. N or lbf). This is the least C that yields the desired life for load P.
- P – equivalent constant load on the bearing (N or lbf, consistent with $C_{\min}$).
- L_{desired} – desired life (in **millions of revolutions**). If life is given in hours, convert it to revolutions using the expected speed before using this formula.
- a – life exponent (same as before: 3 for ball bearings, 10/3 for roller bearings).
- **Assumptions:** Same conditions as the standard life formula (steady load, 90% reliability L10 criterion, etc.). We assume you want an L10 life at least as long as L_{desired}.
- **Scope and use:** Use this formula when **selecting a bearing** to meet a life requirement. It's the inverse of the life calculation: instead of finding life from C and P, you're finding C from life and P.
- Ensure P is the proper equivalent radial load if axial components exist (use factors X, Y as needed – the exam handbook provides equations for combining loads).
- After calculating $C_{\min}$, in practice you would pick a bearing from a catalog with C at least that large (often the next standard size up).

Limit considerations:

- If the required life is the standard 1 million revolutions ($L_{\text{desired}} = 1$), this formula simplifies to $C_{\min} = P$. (Makes sense: to get 1 million rev of life, you need C at least equal to the load P.)
- If a very long life is desired (large L_{desired}), $C_{\min}$ will be significantly higher than P. There is a practical limit – extremely high C values might only be achieved by very large bearings or special designs.
- Because of the exponent, required C grows sub-linearly with life. For example, to double the life (say from 5 million to 10 million rev), you don't need to double C; you need to multiply C by $2^{1/a}$ (about 1.26× for ball bearings, since $2^{1/3} \approx 1.26$).

Common exam application: The exam may give a desired life in hours at a certain speed. Convert that to millions of revolutions, then plug into the formula. Alternatively, you might compute L_{10} for a given bearing and see if it meets the life requirement.

Common mistakes to avoid:

- **Skipping the conversion:** Forgetting to convert life in hours to life in revolutions. If a problem says "desired life 20,000 hours at 1200 RPM," first find how many revolutions that is: $20{,}000 \text{ hr} \times 1200 \text{ rev/min} \times 60 \text{ min/hr} = 1.44 \times 10^9$ rev. That's 1440 million revolutions, so $L_{\text{desired}} = 1440$ in the formula. Missing or messing up this conversion will lead to a wrong $C_{\min}$.
- **Using the wrong exponent:** As with life calculation, use $a = 3$ for ball bearings or $a = 3.33$ for rollers when taking the $1/a$ power.
- **Rounding prematurely:** Because of the exponent, rounding intermediate values can introduce error. Keep a few extra significant figures for $L_{\text{desired}}^{1/a}$ calculations, then round $C_{\min}$ at the end. And if choosing from options, remember $C_{\min}$ is a minimum – if your number is 2490 lbf and choices are 2400 or 2600 lbf rated bearings, you must choose the 2600 lbf one (the next higher capacity).

Exam Handbook Search Cues (Not affiliated with or endorsed by NCEES): *bearing selection*, *basic load rating*, *bearing life equation*, *a = 3 for ball*, *equivalent radial load*

Design practice: Always select a bearing with a catalog C value **higher** than your calculated $C_{\min}$. The formula gives a theoretical minimum; in real designs you'd pick the next standard bearing above that requirement (for safety and availability).
Speed and life: Remember, speed doesn't change how many revolutions a bearing can endure, but it changes how quickly those revolutions occur. If you double the RPM, the bearing will reach any given number of cycles in half the time. So high speeds mean you need a higher cycle life (and thus a higher C) to get the same hours of service.
Axial loads: If the bearing has a thrust load component, use the equivalent load formula $P_{\text{eq}} = XF_r + YF_a$ before plugging into the life equations. The exam reference includes typical X and Y factors for different bearing types (e.g. deep-groove ball bearings). In summary, combine loads first, then apply the life formula.
Multiple bearings: If multiple bearings share a load (for example, two identical bearings supporting a shaft), each one sees only a portion of the load. This effectively increases life compared to a single bearing carrying all P. The FE exam might not delve deeply

into this, but be aware: splitting the load can drastically improve L_{10} for each bearing.

Variations and extensions:

- If you are given a required life in **hours** instead of revolutions, always incorporate the speed as described. It's a good practice to write out the conversion: $L_{\text{desired (rev)}} = L_{\text{desired (hours)}} \times 60 \times N$, then divide by 10^6 for use in the formula.
- The exponent $a = 3$ or 3.33 is industry-standard. If a problem specifically mentions a different exponent or "application factor," use what's given. Otherwise, assume ball or roller standard values.
- Sometimes, manufacturers quote bearing life in terms of a reference speed or reference reliability. The FE exam typically sticks to the basic usage: assume 90% reliability and use the formula as-is, unless told otherwise.

Explanation & Analysis: Bearing selection using the life equation is simply the inverse application of the life calculation. You're ensuring the bearing's capacity C is enough for the job. In an exam context, once you compute $C_{\min}$, you might compare it to available options. For example, if you calculate $C_{\min} = 2500$ lbf for a required life, and the answer choices list bearings rated at 2400 lbf, 2700 lbf, 3000 lbf, etc., you would pick the 2700 lbf one (the smallest rating above your requirement). The FE exam usually won't involve looking up a catalog, but the principle is the same: choose a bearing whose rating meets or exceeds the needed value.

To put things in perspective, a bearing with a higher C (dynamic rating) is typically larger or of higher quality. That extra capacity translates into longer life under the same load. Conversely, using a bearing right at or beyond its limit ($P \approx C$) is asking for early failure. The selection formula quantifies this trade-off.

In practice, engineers often design for an L_{10} life much higher than the minimum required, to account for uncertainties and to achieve a reasonable service life. On the exam, however, you'll usually solve precisely for the threshold where 90% of bearings survive the target life. As long as you apply the formula carefully—convert units, pick the right exponent, and interpret the result—you'll reliably arrive at the correct answer for bearing life or selection questions.

Topic 07 - Power Screws

Topic Introduction: Power screws (also known as lead screws) are threaded devices used to convert rotary motion into linear motion, usually to lift or press a load. They provide significant mechanical advantage, allowing a relatively small torque to raise a heavy load. On the **FE Mechanical Exam**, you'll often be asked to calculate the torque required to **raise or lower a load** with a given screw, determine the **efficiency** of the screw mechanism, or check if the screw will **back-drive** (run in reverse on its own). Mastering a few key formulas for power screws—relating torque, load, friction, and thread geometry—will equip you to solve these questions quickly. Typical exam problems might give you the screw's dimensions (diameter, thread pitch), a friction coefficient, and a load, and then ask for the input torque or whether the screw is **self-locking** (i.e. will hold the load in place when you stop turning it). Keep in mind that power screws are essentially **inclined planes wrapped around a cylinder** – this analogy will help you remember the relationships between thread angle, friction, and torque.

K14.T07.S01 – Torque to Raise a Load (Square-Thread Screw)

Principle Introduction: Raising a heavy load by turning a power screw requires overcoming both the weight of the load and friction along the threads. The screw's **lead angle** (α) – the angle of the thread's incline – gives the ideal mechanical advantage if there were no friction. In reality, friction between the screw and nut threads (characterized by a friction coefficient μ, or equivalently a **friction angle** φ where tan φ = μ) resists motion and increases the required torque. The result is a formula for the **torque required to raise the load (T_R)** that combines the effect of the thread incline and friction. For a **square-thread power screw** (which has thread faces at 90°, so no wedging due to thread profile), the core formula is derived from balancing forces on that inclined plane analogy of the thread.

Exam Handbook Search Cues (Not affiliated with or endorsed by NCEES): *power screws; square thread; raise load torque; coefficient of friction; lead (l); mean diameter (d_m)*

Equation Passport: Square-Thread Lifting Torque – computes the torque needed to **raise** a load using a square-thread power screw (overcoming gravity and thread friction).

Equation (raise load): $T_R = F\,\frac{d_m}{2}\tan(\alpha+\varphi)$

This formula gives the **input torque** T_R required to lift (raise) a load F with a screw, accounting for thread friction. Here α is the thread's lead angle and φ is the friction angle (with $\tan\varphi = \mu$). If a **collar** or thrust bearing is present under the rotating surface, an additional torque to overcome its friction must be added (see subtopic K14.T07.S03). For now, this equation focuses on thread friction only.

Variables and Units:

F – load force (the weight or force being lifted) – [N] in SI or [lb_f] in USCS.

d_m – **mean thread diameter** (average of the outer and inner thread diameters) – [m] or [in].

α – **lead angle** of the thread (angle of the thread incline with respect to a plane perpendicular to the screw's axis) – [rad] (use degrees in calculator with tangent carefully).

μ – coefficient of friction between the screw and nut (dimensionless). Often given or assumed for steel-on-steel, etc.

φ – **friction angle**, where $\tan\varphi = \mu$ – [rad] or [°]. (It's the angle such that a surface tilted at φ would just start to allow the block to slide due to that friction.)

T_R – required torque to raise the load (often at constant slow speed) – [N·m] or [lb_f·ft] (units of force × distance).

Assumptions and Scope:

– **Static equilibrium:** The formula assumes a slow, steady lift (no acceleration), so inertia is negligible and static friction is in effect (or kinetic friction with similar coefficient).

– **Square threads:** We assume square threads with negligible thread face angle. This means no radial force component due to thread geometry; all friction is modeled via μ. (For Acme or trapezoidal threads, a similar formula applies but μ must be adjusted by the thread angle.)

– **No bending or deflection:** The screw is rigid, and the load is purely axial. We ignore any bending of the screw or deformation of threads.

– **Single-start thread:** Lead *l* equals the thread pitch *p* (one thread). If a screw has multiple thread starts (two-start, etc.), the lead angle α is larger (l = n·p) and that influences T_R (multiple-start screws are less self-locking). The formula still applies with the appropriate *l*.

– **Units consistency:** All linear dimensions must be in the same units when calculating (e.g., if F is in N and distances in mm, convert mm to m, or get torque in N·mm).

Limit Tests (sanity checks):

– *If friction is zero ($\mu = 0$):* Then $\varphi = 0$ and $\tan(\alpha+\varphi) = \tan\alpha$. The formula reduces to $T_R = F\,\frac{d_m}{2}\tan\alpha$. For a small lead angle, $\tan\alpha = \alpha$ (radians) approximately, so this matches the ideal no-friction torque. If $\mu = 0$, the screw is 100% efficient (all input work lifts the load).

– *If the thread is vertical ($\alpha \to 0$):* $\tan(\alpha+\varphi) \approx \tan\varphi = \mu$. Then $T_R \approx F\,\frac{d_m}{2}\mu$. This makes sense: a very fine (almost vertical) thread is like a bolt – you're basically just overcoming friction by turning with no significant lifting per turn, so torque is just frictional (no incline advantage).

– *If friction is very high:* As μ (and thus φ) grows, $\tan(\alpha+\varphi)$ grows. For extremely large friction, T_R becomes huge (approaching infinite as $\alpha+\varphi \to 90°$), meaning the screw is almost impossible to turn – all your effort is lost to friction, and efficiency goes to zero.

Use vs. Sibling Equations: *Use this equation instead of simpler ideal models when thread friction is significant.* In contrast to a **frictionless** simple machine formula ($T = F\,\frac{d_m}{2}\tan\alpha$ for an ideal

screw or inclined plane), this formula should be used on the exam whenever a **coefficient of friction** is given for the screw threads. It also supersedes using an efficiency approximation unless efficiency is directly provided; you can derive efficiency from this formula if needed.

Common Exam Traps:

– **Mixing degrees and radians:** If you plug angles into $\tan(\alpha + \varphi)$, be careful with your calculator mode. You can convert α and φ to degrees (since friction coefficient gives φ in degrees via arctan) and use degree mode, or convert everything to radians. Just be consistent. Many errors come from taking tan of an angle in degrees while the calculator is in radian mode (or vice versa). A safe approach: compute $\varphi = \arctan(\mu)$ in degrees (common), then add to α (which might be given via lead and diameter; convert that to degrees too by $\arctan\big(l/(\pi d_m)\big)$ in degrees). Then take tan of the sum in degree mode.

– **Using diameter incorrectly:** Ensure you use the mean diameter d_m (approximately the midpoint of thread engagement) in this formula, not the outer diameter directly. If only outer diameter and pitch are given, you can get $d_m \approx d_o - 0.5p$ for a square thread (since thread depth ~ half the pitch). Using d_o instead of d_m will **underestimate** the required torque, because the leverage arm is slightly shorter than outer radius due to thread depth.

– **Forgetting friction (or using wrong μ):** Occasionally, examinees might plug in the coefficient of friction for the **collar** or some other value incorrectly. Make sure to apply the thread friction coefficient in this formula. If a collar is present, handle its friction separately (usually by adding another torque term, see below).

– **Unit confusion in torque:** Remember that torque = force × distance. If force is in N and diameter in mm, the torque comes out in N·mm (which is fine, but you may want to convert to N·m by dividing by 1000 for a final answer). Similarly, a weight given in kilograms (mass) must be converted to Newtons (force) by multiplying by *g* (9.81 m/s²) before using in the formula, if needed.

Footnotes:[1] *It's implied that the screw is* preventing *the load from falling when you're not turning it (self-locking); we'll cover that separately.* [2] Square threads are standard in lead screws because they minimize radial forces and have better efficiency than trapezoidal threads – plus easier analysis. Unless the exam specifically mentions a thread angle (e.g. 30° Acme thread), assume square threads. In USCS units, a common mishap is mixing up lb_m and lb_f. Here F should be in pounds-force (lbf). If a mass in lbm is given, multiply by $g \approx 32.17$ ft/s^2 (in US units) to get lbf. Remember 1 lbf = 1 lbm · 32.17 ft/s^2.

Variations, Related Forms, Typical Values:

- **Alternate form using efficiency:** Sometimes the problem might directly give an **efficiency (η)** for the screw instead of friction coefficients. In that case, an equivalent expression for required torque is $T_R = \frac{F\,(d_m/2)}{\eta}$. This comes from $\eta = \frac{\text{Work out}}{\text{Work in}} = \frac{F \cdot l}{T_R \cdot 2\pi}$ (see subtopic K14.T07.S03). If you know η (decimal form), it's often quicker to use this than to compute from μ and α. Remember that efficiency accounts for **both** thread and collar friction if given as an overall value.

- **Multiple-thread (multi-start) screws:** A double-start or triple-start screw has a larger lead *l* (e.g. 2× or 3× the pitch) for the same diameter, which increases α and thus requires *less torque* to raise the same load (because the thread incline is "steeper"). However, higher lead angles risk losing the self-locking property (more on that soon). For example, a screw jack might use a single-start thread for self-locking, whereas a fast-moving lead screw in a machine (not self-locking by design) could be multi-start to reduce friction and increase speed. The same formula applies with the appropriate lead.

- **Typical friction values:** For dry steel threads, μ is around 0.15–0.2 (friction angle φ ~ 8.5°–11°). Well-lubricated threads might have μ ~ 0.05–0.1 (φ ~ 2.9°–5.7°). These values mean that if the lead angle α is on the order of only a few degrees (common in jack screws, e.g. α = 3°–5°), the screw might be safely self-locking. But if you lubricate a screw jack too well (μ drops), it could approach the overhauling condition where it might back-drive! Always consider the given μ in relation to α for self-locking.

- **Effect of thread profile (FYI):** If the problem does mention a thread like **Acme (29°)** or trapezoidal threads, the analysis is similar but the effective friction is slightly higher because the normal force is not perpendicular to motion. In such cases, one approximation is to replace μ with $\mu/\cos(\beta)$ where β is half the thread angle (14.5° for Acme). This effectively increases the torque required. However, unless explicitly asked, the FE exam usually avoids this complication by either specifying square threads or providing an efficiency to use directly.

Special Notes – Calculator Usage: When using this formula on the allowed calculators (Casio fx-115/991, TI-36X, HP 35s, etc.), it's crucial to group terms correctly. For example, to compute $T_R = F\frac{d_m}{2}\tan(\alpha + \varphi)$, first calculate $\alpha + \varphi$ (either both in degrees or both in radians) then take the tangent. On a TI-36X Pro in degree mode, you might do: tan((alpha_deg) + (atan(mu)*DEG)) if you have μ instead of φ directly (the *DEG converts the arctan result to degrees in some calculator syntaxes, or you can just calculate numerical φ in degrees beforehand). Always double-check that the angle mode is correct and that you're not, say, using degrees for one angle and radians for the other. A quick mental estimate can save you: e.g., if α ≈ 5° and μ = 0.15 (φ ≈ 8.5°), then α+φ ≈ 13.5° and tan should be ~0.24. If your calculator gives something wildly different (like 0.003 or 7.2), you know something's off with the mode or input. Also, ensure that when using a fraction or alternative form, you include parentheses: for instance, the fraction form $T_R = \frac{F d_m}{2}\frac{l + \pi\mu d_m}{\pi d_m - \mu l}$ requires careful entry. It might be safer to break it into steps (compute numerator and denominator separately) to avoid confusion.

Explanation & Analysis (Step-by-Step): Think of lifting a weight with a screw jack: you apply a torque T_R to the screw's handle, which creates a twisting force that pushes the nut (or the load platform) upwards. The **basic idea** behind the torque formula is that the screw thread is like a circular **inclined plane**. If you unwrap one turn of the thread, you'd have an incline of height *l* (the lead) over a length πd_m (the circumference traveled in one revolution). The weight F wants to slide **down** that incline. To lift the weight, you must push it **up** the incline by applying a tangential force at the screw radius (that tangential force times radius is your torque). Without friction, the minimum force needed along the plane would be $F\tan\alpha$, and thus torque $= F\tan\alpha \cdot (d_m/2)$. With friction, it's as if the incline is steeper – the force needed is $F\tan(\alpha + \varphi)$, where φ accounts for the extra incline due to friction resistance (literally the angle of friction). So $T_R = F(d_m/2)\tan(\alpha + \varphi)$ is the equilibrium condition: it ensures the tangential component of your input force overcomes both gravity **component down the thread** ($F\tan\alpha$) and the **frictional drag** ($F\tan\varphi$) along the thread.

Let's break down the formula term by term: F is the load you're lifting (Newtons or pounds of force). The factor $(d_m/2)$ is the **moment arm** – effectively the radius at which that tangential force acts (half the mean thread diameter, since the force between screw and nut is applied roughly at the midpoint of the thread depth). The $\tan(\alpha + \varphi)$ part encapsulates the combined slope and friction. It grows quickly if friction is high or the thread is steep. Each symbol: α (alpha) is small for fine threads and larger for coarse threads; φ (phi) grows with roughness or poor lubrication. If either α or φ increases, the required torque goes up: a steep thread (α large) means you're lifting faster per turn but need more force per turn (just like a steep ramp requires more force to push something up). A high friction φ means energy is wasted as heat, so again more input needed.

One common pitfall in analysis is **forgetting the difference between raising and lowering**. The above formula gives the torque to **raise** the load. When lowering, the friction actually helps you (it resists the downward motion), so you don't need as much torque to lower – in fact you might even need to apply a reverse torque to *prevent* too fast a descent if the screw is not self-locking. We'll discuss the **lowering torque** formula separately (K14.T07.S04), but it's basically $T_L = F\frac{d_m}{2}\tan(\varphi - \alpha)$ for cases where the screw is self-locking (meaning $\varphi > \alpha$). If φ is bigger than α, $\tan(\varphi - \alpha)$ is positive, so you still have to crank (in the opposite direction) to slowly lower the load; if φ is smaller than α (an overhauling screw), $\tan(\varphi - \alpha)$ would be negative, indicating the load will turn the screw by itself if you let it – a dangerous scenario unless controlled.

In summary, this subtopic's formula is your go-to for any problem where you need the input torque to lift a load with a screw. Always plug in the mean diameter and mind the friction. If no friction is given, you might assume an ideal case (or they might be testing if you know to assume some typical μ ~ 0.15 if not stated, but the exam usually provides it or an efficiency). Once you have T_R, you can further analyze efficiency or check self-locking, which we'll do next. The key takeaway: **more friction or a steeper thread = more torque needed**. Make sure to remember $\tan(\alpha + \varphi)$ – it's doing the heavy lifting in this equation (pun intended!).

K14.T07.S02 – Self-Locking Condition for Power Screws

Principle Introduction: A **self-locking power screw** is one that will **not back-drive** – in other words, if you stop applying torque, the screw will hold the load in place instead of unwinding. Self-locking is a crucial safety feature for screws like jacks, presses, or clamps: you don't want a heavy load coming down just because you let go of the handle. The condition for self-locking is a relationship between the thread's lead angle and friction. Intuitively, if the thread incline is too steep (high lead angle) compared to the friction, the load's downward force can overcome friction and turn the screw (that's called **overhauling**). But if the thread is shallow enough or friction is high enough, the screw will grip and stay put. The formal criterion involves comparing the **lead angle (α)** to the **friction angle (φ)** from before.

Exam Handbook Search Cues (Not affiliated with or endorsed by NCEES): *power screw; self-locking; back-drive; lead angle; friction coefficient* (Note: The exam reference may not explicitly use the term "self-locking," but the concept is implied by the friction and lead angle context. Look for the condition in the explanation of power screws or derive from the torque formulas.)

Definition/Note Passport: Self-Locking Screw

- **Plain-language definition:** A *self-locking* screw is one where the **friction** is sufficient to prevent the screw from turning by itself under the load. In other words, when you stop applying torque, the load **stays in place** instead of driving the screw in reverse.

- **Where it matters (exam impact):** This concept appears when a problem asks if a screw will hold a given load without external help, or when checking if lowering the load requires a positive torque. You might be given μ and thread info and need to conclude "Yes, it's self-locking" or find the factor of safety against back-driving.

- **Key condition (criterion):** For a screw to be self-locking: $\tan\alpha < \mu$ (equivalently $\alpha < \varphi$). This inequality is the heart of it – the thread angle must be smaller than the friction angle. If $\tan\alpha$ is less than the friction coefficient, the screw will not back-drive. At the borderline case $\tan\alpha = \mu$, the screw is *just barely* self-locking (it's neutrally stable – in theory it would hold position, but any slight jostle could make it turn).

- **Pitfall or confusion point:** Don't confuse *self-locking* with *efficiency*. A screw can be self-locking (won't fall on its own) yet still have low or high efficiency separately. Also, remember that **static friction** is what truly locks it; if the load is vibrating or if friction is reduced (lubrication), a marginally self-locking screw might start moving. For exam purposes, assume ideal conditions (no shock or vibration) – if $\tan\alpha < \mu$, it's safely self-locking. Another common confusion: sometimes students mix up the condition as $\mu < \tan\alpha$ by inverting it – be careful, it's μ on the right, not $1/\mu$. Writing it as $\mu > \tan\alpha$ might be less confusing (friction coefficient bigger than incline slope).

- **Micro-check:** *True/False?* A **ball screw** (which uses ball bearings to greatly reduce friction) is usually *not* self-locking. **(True)** – Ball screws have very low μ (often < 0.05), so unless the thread angle is extremely low, they tend to back-drive and thus require a brake or motor hold to keep position.

Footnotes: [1] Technically, the **collar friction** can also contribute to self-locking. Even if $\tan\alpha$ is slightly greater than μ (thread not self-locking by itself), a sticky collar with its own friction μ_c might keep the system from back-driving. However, the exam typically focuses on the thread condition alone, unless data is given for a collar. [2] If you encounter a question about "overhauling" screws: an *overhauling screw* is just the opposite of self-locking – it means $\tan\alpha > \mu$, and the screw will turn on its own if the load is trying to descend. [3] Safety: In real design, engineers prefer a comfortable margin where $\tan\alpha$ is quite a bit smaller than μ for self-locking, because things like vibration or slightly lower friction (oil, wear) could defeat a marginal case. On the FE Exam, however, you can assume ideal static conditions unless told otherwise.

Variations and Special Cases:

- **Neutral case:** When $\tan\alpha = \mu$ exactly, the screw is on the verge of self-locking. In theory, a load on such a screw wouldn't move on its own, but if nudged it might go either way. This is rarely used in practice, but it's a theoretical boundary (efficiency at this point would be very low, approaching zero).

- **Overhauling screws:** If $\tan\alpha > \mu$, the screw will back-drive (overhaul). This means if you release the wrench, the load will start spinning the screw and come down – like a heavy nut unwinding. Overhauling screws are actually common in applications where you *want* quick motion and don't mind needing a brake (e.g., garage door openers or some actuators use acme threads with low friction or high lead, relying on a motor brake to hold position). If the exam

question gives a scenario with a high lead angle or explicitly asks, "Will the load descend under its own weight?", they're testing this concept.

- **Effect of multiple thread starts:** Multi-start screws have higher lead for the same pitch, which increases α. Thus, a double-start screw is more prone to overhauling than an otherwise identical single-start screw. For example, if a single-start screw was barely self-locking, making it double-start (doubling l) could make it overhauling. So multi-start screws are generally not self-locking unless friction is also increased.

- **Back-drive prevention:** If a screw is not self-locking, designers must incorporate something else to hold the load (e.g. a brake, ratchet, or motor holding torque). On the exam you might not design such things, but you should recognize when a screw alone isn't enough to hold a load.

- **Ball screws vs. acme vs. square:** As noted, ball screws have such low friction that they are **never** self-locking in normal designs; they're prized for efficiency but require brakes. Acme threads (with moderate friction) can be self-locking if the thread is shallow enough, but typically many acme threads (like those in clamps or vises) are designed to be self-locking. Square threads can be very efficient, but if you choose dimensions so that α is low, they can be self-locking too. The condition doesn't change: use the same $\tan\alpha$ vs. μ test for any thread form (just remember to adjust μ if needed for thread angle as mentioned before).

Special Notes: On your calculator, you might need to compute α or φ from given data to test this condition. If the problem provides a screw's dimensions, you can find $\tan\alpha = \frac{l}{\pi d_m}$ (with l = lead per turn). Compute that numeric value and compare to given μ. It's often easiest to compare **numerically**: e.g. "$\tan\alpha = 0.08$ and μ = 0.15, so yes $\tan\alpha < \mu$, self-locking." No need to actually solve for α or φ in degrees unless asked; a numeric comparison is enough and avoids any confusion about angle units. Make sure to use consistent units (both dimensionless): $\tan\alpha$ is already dimensionless, as is μ. Also, be aware of any trick like providing a **static** and **kinetic** friction coefficient; self-locking is really about static friction. If both are given, use static μ for the condition (it's higher, making it easier to satisfy $\mu_s > \tan\alpha$).

Explanation & Analysis: Why does $\tan\alpha < \mu$ ensure self-locking? From a physics standpoint, consider the forces on the screw threads as if it were an inclined plane (see the figure above). The weight F produces a component parallel to the thread trying to **slide the nut down**. That component is $F\sin\alpha$ (or equivalently $F\tan\alpha$ compared to the normal force). Friction provides a resisting force up the plane, whose maximum (static) is $\mu F\cos\alpha$ (equivalent to $F\mu$ in magnitude times the normal direction). The condition for the nut not to slide is friction >= downhill component, i.e. $\mu F\cos\alpha \geq F\sin\alpha$. Simplify that: $\mu\cos\alpha \geq \sin\alpha$, or $\mu \geq \tan\alpha$. That's exactly the inequality. In words: *the screw's friction must be "stickier" than the tendency of the load to slide.* If that holds, the load can't overcome friction to turn the screw on its own.

Another way to see it: recall the torque expressions from the prior subtopic. The lowering torque T_L (to *unscrew* or lower the load) would be $T_L = F\frac{d_m}{2}\tan(\varphi - \alpha)$. If the screw is self-locking, $\varphi > \alpha$, so $(\varphi - \alpha)$ is positive, meaning T_L comes out positive. That implies you actually have to apply a torque to make it lower – it won't go by itself. If instead $\alpha > \varphi$ (not self-locking), then $(\varphi - \alpha)$ is negative; the formula would give a negative torque, which essentially means the load will turn the screw without your input (in fact you'd need to apply a braking torque to restrain it). So the sign of $\varphi - \alpha$ (or equivalently the sign of $\mu - \tan\alpha$) is the mathematical indicator of self-locking.

For exam purposes, you typically won't derive all that; you just need to check the numbers. Remember that α might not be given explicitly – you might have to calculate it from screw geometry: $\alpha = \arctan\left(\frac{l}{\pi d_m}\right)$. A common mistake is to use the **outer diameter** instead of d_m in that formula, which slightly underestimates α (making it easier to think it's self-locking than it actually is). Use the mean diameter for best accuracy, but if not given, using the outer diameter is a rough approximation (the difference is usually small for fine threads).

Finally, consider a practical perspective: You've probably tightened a vise or a car jack and noticed that you can let go and it doesn't unwind. That's self-locking in action. If you've ever seen an older garage door mechanism or some lead screws on machinery that *do* spin back when released, those are overhauling screws – by design, they sacrifice self-locking for easier motion or higher efficiency, and rely on something else to stop motion. On the FE exam, unless they specifically mention a brake or ask about "overhauling," they usually expect that power screws in lifting applications are self-locking (or they'll ask you to verify it). So keep this inequality in mind: **friction must trump the thread angle for safety**.

K14.T07.S03 – Power Screw Efficiency and Collar Friction

Principle Introduction: Not all the work you put into turning a power screw goes into lifting the load – much of it is lost to friction. The **efficiency (η)** of a power screw is the ratio of useful work out (lifting the weight) to the work you put in (turning effort). A high efficiency means you get more lift for less torque; a low efficiency means the screw is wasting a lot of your effort as heat. Typical power screws, due to friction, have rather low efficiencies (often well below 50%). In the FE exam context, you might be asked to compute the efficiency given a screw's geometry and friction, or use a given efficiency to find required torque. Additionally, many screws have a **collar** or thrust bearing at their rotating support (for example, the base of a jack or under a bolt head) – friction there adds to the torque required but does **no lifting**, further reducing efficiency. We need to account for collar friction if mentioned: essentially it's an extra torque T_c that simply eats up input energy. This subtopic ties together the earlier formula for T_R with the concept of efficiency, and how to include collar friction in calculations.

Exam Handbook Search Cues (Not affiliated with or endorsed by NCEES): *power screw efficiency; $\eta = \frac{Fl}{2\pi T}$; collar friction; thrust collar*

Equation Passport: Power Screw Efficiency – quantifies how much of your input work is converted into lifting the load (useful work) for a power screw.

Efficiency definition: $\eta = \frac{\text{Work Output}}{\text{Work Input}} = \frac{F\,l}{T_R\,(2\pi)}$

Here "Work Output" is the work done in raising the load one full turn (force F moved through distance l, the lead), and "Work Input" is the work you do by applying torque T_R through one full revolution (torque times angle 2π radians). The result η is a dimensionless fraction (often expressed as a percentage).

Variables and Units:

η – efficiency of the screw (0 to 1, or 0–100%). It's dimensionless (e.g. 0.30 or 30%).

F – load force being lifted [N or lb_f].
l – lead of the screw per turn [m or in]. (This is the distance the load moves axially in one revolution. $l = p$ for single-start threads.)
T_R – torque to raise the load at constant speed [N·m or lb_f ·ft].
2π – one full revolution in radians. (No units, since it's a pure number when multiplying by torque in N·m to get work in J: $N \cdot m * radians$ yields N·m which is J. In US units, use 2π with torque in, say, lbf·ft to get work in lbf·ft, which can be converted to say ft· lb_f, but you can stay in consistent units for the ratio.)

Assumptions and Scope:

– The formula assumes **steady motion** (no acceleration) and that the same torque T_R is applied throughout the revolution. In practice, friction might vary a bit, but we assume constant for calculation.

– Efficiency can be calculated for **raising** the load. For **lowering**, if the screw is self-locking, you could compute a "lowering efficiency" similarly by using T_L in place of T_R (it will be higher than raising efficiency because friction helps in lowering). If the screw is not self-locking (overhauling), efficiency in lowering isn't a relevant concept, since the load is doing work on the screw (it would be more than 100% efficient in that sense, which just means it's driving itself). The exam will typically stick to raising efficiency or overall efficiency if anything.

– We assume all losses are due to thread friction (and possibly collar friction, handled as an extra term). There's no other energy loss (no bending, no vibrations, etc.).

– Units note: Because efficiency is a ratio of like units, it doesn't matter if you use N and m or lbf and ft, etc., as long as you're consistent. The 2π is in radians and doesn't need unit conversion.

Including collar friction: If a **collar** (a flat bearing surface) is present and you're given its mean diameter d_c and friction coefficient μ_c, the **additional torque** to overcome collar friction is: $T_c = F\,\frac{d_c}{2}\,\mu_c$. This T_c simply adds to the required torque but provides no additional lift. So the **total torque** to raise the load becomes $T_{\text{total}} = T_R + T_c$ (where T_R is the thread torque from earlier formula, using μ for threads). The efficiency then would be $\eta = \frac{Fl}{(T_R+T_c)2\pi}$. Collar friction can significantly reduce efficiency, especially if the collar diameter is large. On the exam, if they mention a collar, be sure to add this term to the denominator of work input. If they ask specifically for thread efficiency vs overall, T_R alone gives thread efficiency, and including T_c gives overall efficiency.

Limit Tests:

– *No friction case:* If μ = 0 (and $\mu_c = 0$), then T_R would be $F\,\frac{d_m}{2}\tan\alpha$ and actually that equals $F\,\frac{l}{2\pi}$ (since $\tan\alpha = \frac{l}{\pi d_m}$ for a single turn). Plugging that in: $\eta = \frac{Fl}{\left(F\frac{l}{2\pi}\right)2\pi} = 1$. So as expected, a frictionless screw is 100% efficient (all input work goes into lifting).

– *Extremely high friction:* If μ is very large (or α very small), T_R becomes huge and efficiency η approaches 0. For instance, if a screw is self-locking with a large margin (say μ = 0.3 and α = 0.05 rad), you might get an efficiency of maybe 10–20%. That means 80–90% of your effort is wasted overcoming friction. This is the trade-off: self-locking often comes with low efficiency.

– *Including collar, if d_c is big:* Imagine a wide collar (large d_c) with substantial friction μ_c; T_c might even exceed T_R in magnitude. Efficiency then drops further. If T_c is, say, equal to T_R, then only half your torque is doing lifting work and the rest is just heating the collar – efficiency would be 50%. If T_c is double T_R, efficiency would be only 33%. So a note: minimize collar diameter or lubricate it to improve efficiency in designs.

Use vs. Alternative Approaches: Use this efficiency formula whenever you want to quickly get the relationship between torque and work. The alternative is to derive efficiency from thread geometry: there is a known formula $\eta = \frac{\tan\alpha}{\tan(\alpha+\varphi)}$ (for raising) which comes directly from our T_R formula ratio. You can use that too if you find it easier – it's equivalent. For instance, $\frac{\tan\alpha}{\tan(\alpha+\varphi)}$ gives the same number as $\frac{Fl}{2\pi T_R}$. If a problem gives you angles, that might be faster. But if you already computed or have T_R, plugging into $\frac{Fl}{2\pi T_R}$ is straightforward. There really isn't a "sibling" equation to confuse with here, except maybe efficiency in other machines (like gear efficiency or something). Just remember this is specifically for the screw and one turn's work.

Common Exam Traps:

– **Mixing up numerator/denominator:** The formula

$$\eta = \frac{F\,l}{2\pi T_R}$$

is easy to invert by mistake. A quick check: efficiency must be ≤ 1. So if you accidentally compute $(2\pi T_R)/(F\,l)$, you'll likely get a large number ($\gg 1$) which is nonphysical. Keep it straight: lifting work $(F\,l)$is usually smaller than input work. A good practice is to estimate: if the screw is self-locking, efficiency might be in the tens of percent. If you calculate $\eta = 4.2(420\%)$, you definitely flipped it.

– **Using diameter instead of radius in work input:** The work input per turn is

$$W_{\text{in}} = 2\pi T_R$$

(with $T_R$already computed from torque relationships that involve radius). Occasionally someone might think to use circumference times force, etc. Stick to the formula given. Torque already contains radius, so $2\pi T_R$inherently accounts for the radius correctly. Don't double-use the radius.

– **Forgetting to add collar friction:** This is huge. If the problem clearly states there's friction at a collar or a thrust bearing, and asks for efficiency or total torque, you must include the collar's torque in the calculation:

$$T_{\text{total}} = T_{\text{thread}} + T_{\text{collar}}.$$

Many students focus on the thread and completely forget the collar contribution. The exam might nudge you by giving μ_c and d_c values; that's a clue to incorporate them.

– **Unit consistency again:** Ensure $l$and $d$are in the same unit system. If you compute $F\,l$in N·m (J) and $T_R$in N·m, all good, the 2π is unitless. If you use, for example, Fin lbf and $l$in inches, and $T_R$in lbf·in, that also works because the units cancel in the ratio. Just avoid mixing (like Fin lbf, $l$in inches, and $T_R$in lbf·ft without converting).

– **Percentage vs fraction:** If an answer needs a percentage, multiply $\eta$by 100%. A minor thing, but sometimes the exam might frame it like "what is the efficiency of this screw?" and answers could be like 0.27or 27%. Just be clear on what form you should provide or interpret.

Footnotes: [1] The exam reference often provides $\eta = \frac{Fl}{2\pi T}$ in the **Power Screws** section, which is handy. But remember, that T in the handbook formula is specifically the raising torque T_R. If you somehow plug in a lowering torque or some other value, you'd get a meaningless result. [2] If no friction values are given but efficiency is, use it directly. For example, "the screw has an efficiency of 35%" – then $T_R = \frac{Fl}{2\pi\eta}$. This might save time. [3] Collar friction is sometimes described by an "equivalent friction radius" or given in tables. If the problem says something like "include a collar friction torque of X N·m" you can just add it. But if it gives μ_c and a collar diameter, use $T_c = F(d_c/2)\mu_c$. In case only radius is given, obviously use that radius (which is $d_c/2$).

Variations, Related Forms, Typical Values:

- **Formula in terms of angles:** As noted, using $\eta = \frac{\tan\alpha}{\tan(\alpha+\varphi)}$ is an alternative way to get efficiency (for raising) if you know the angles or can compute them. This comes from substituting $T_R = F\frac{d_m}{2}\tan(\alpha+\varphi)$ and noting that $l = d_m\tan\alpha * (somefactor)$. Actually derivation: $T_R * 2\pi = Fd_m/2 * 2\pi * \tan(\alpha+\varphi) = F\pi d_m\tan(\alpha+\varphi)$. Meanwhile $Fl = F(\pi d_m\tan\alpha)$. Taking the ratio $Fl/(T_R 2\pi)$ simplifies to $\frac{\tan\alpha}{\tan(\alpha+\varphi)}$. It's elegant and sometimes quicker if μ and dimensions are such that calculating α and φ isn't too cumbersome. But beware of unit consistency for angles if you try to plug in directly in calculator – better to compute tan values numerically.

- **Typical efficiency numbers:** For a square-thread screw jack with no collar and moderate lubrication (μ ~ 0.1, α a few degrees), you might see efficiencies around 30–50%. Dry, unlubricated threads (μ ~ 0.2) with a shallow angle might be down at 15–25%. Add a collar and it can drop further. For example, a screw with thread efficiency 35% might only be 25% overall if there's a significant collar friction. On the high end, multi-start or ball screws (low μ, larger α) can reach 70–90% efficiency, but those are not self-locking. It's a trade-off: the more efficient, the more likely it is to back-drive.

- **Thread vs overall efficiency:** Sometimes a problem might implicitly have you calculate thread efficiency and ignore collar friction (if not mentioned). Other times, they explicitly want overall. Just clarify: **Thread efficiency** uses only T_R (thread friction considered) in the denominator; **Overall efficiency** uses $T_R + T_c$. If the exam problem gives both μ and μ_c, they expect you to include both in your efficiency calculation (unless the question specifically isolates one).

- **Reversible machines:** Efficiency can conceptually exceed 100% in a sense when the machine is being driven by the load (like an overhauling screw lowering a weight can turn a generator). But in standard definition, we cap efficiency at 100%. So you won't be asked for efficiency of a non-self-locking screw during lowering, because that scenario is more like generating power from the load, not something we call "efficiency" in the usual sense. If they ask anything, they'll stick to raising efficiency or just label it efficiency of the screw (implicitly for lifting).

- **Improving efficiency:** Just a conceptual note – to improve a screw's efficiency, you reduce friction (lubricate, use ball bearings) or increase the lead angle (multi-start threads). But both of those moves risk losing self-locking. That's why designs that need high efficiency (like fast-moving actuators) often are not self-locking and need brakes, whereas designs that need holding (like jacks) accept low efficiency.

Special Notes – Calculator Tips: Calculating efficiency is straightforward division and multiplication, but watch out for the 2π factor. A common mistake is to forget the 2π entirely. If you have $F, l,$ and T_R, do it step by step: compute $F * l$ (this is $work_{out}$ in, say, joules or lbf·ft units), then compute $T_R * 2 * \pi$ ($work_{in}$). Then do the ratio. On a Casio or TI, you might input: (F * lead) / (2 * pi * T). Ensure you include the 2 * pi * T in parentheses in the denominator if doing in one line, or just do it in two steps. If the numbers are small or large, you can expect η to be a number less than 1. For instance, if raising a 10 kN load by a 5 mm lead screw requires 100 N·m torque, efficiency = (10000 N * 0.005 m) / (2π * 100 N·m) = 50/(628) ≈ 0.0796 (7.96%). If you got something like 12.5 (1250%), you likely divided the wrong way. So a quick mental check: output work (N * m of lift) vs input work (N·m * radians); output is usually much smaller due to friction.

Explanation & Analysis: Efficiency tells you "how much bang for your buck" you get when turning the screw. Let's interpret the formula $\eta = \frac{Fl}{2\pi T_R}$. The numerator Fl is literally the work done lifting the weight one turn: if you raise a 1000 N weight by, say, 5 mm per turn, that's $1000 * 0.005 = 5$ J of work out per turn. The denominator $2\pi T_R$ is the work you put in by turning: if it took 20 N·m of torque to do it, one full revolution (2π rad) means $2\pi * 20 \approx 125.66$ J of work in. So efficiency $\eta = 5/125.66 = 0.0397$ or about 4%. Ouch – that's quite low! It means 96% of your energy went into overcoming friction. This could happen if μ is large or the thread is very shallow (lots of friction distance for little lift).

Now, how do we get T_R if not given? You'd use the formula from subtopic S01: $T_R = F\frac{d_m}{2}\tan(\alpha+\varphi)$. If you plug that into the efficiency formula and simplify, indeed you get $\eta = \frac{\tan\alpha}{\tan(\alpha+\varphi)}$. This relation is insightful: it shows that efficiency is basically the ratio of "what you ideally would need (tan α) vs what you actually need (tan(α+φ))". If friction is zero, $\tan\varphi = 0$ so it's $\tan\alpha/\tan\alpha = 1$ (100%). If friction is not zero, $\tan(\alpha+\varphi) > \tan\alpha$, so the ratio is less than 1.

Now, add a collar friction T_c. The collar is like a simple flat-bearing under the screw head or nut. For example, picture a C-clamp: as you tighten the screw, the end of the screw rubs against the clamp frame – that's collar friction. It doesn't lift the clamp, it just wastes your effort. The formula $T_c = F\frac{d_c}{2}\mu_c$ is basically friction torque = friction force * radius. The normal force at the collar is the same F (the load pushes back on the collar). The friction force = $F\mu_c$ (assuming uniform pressure at mean diameter), acting at radius $d_c/2$. So torque = $F\mu_c(d_c/2)$. If the problem provides the collar dimensions, you compute that and tack it onto the thread torque. Then use $T_R + T_c$ in the denominator of efficiency.

Let's do a quick analysis example to illustrate everything: Suppose you have a screw jack lifting 10 kN (about 2248 lbf) with a single-start square thread of $d_m = 30$ mm, pitch $p = 5$ mm (so lead $l = 5$ mm). The steel screw is greased ($\mu = 0.1$ for threads) and there's a collar of mean diameter 40 mm with $\mu_c = 0.05$. First, find α: $\tan\alpha = l/(\pi d_m) = 5/(\pi 30) \approx 0.053$, *so* $\alpha \approx 3.03°$. *Friction angle φ:* $\tan\varphi = 0.1$, *φ ≈ 5.71°. Clearly φ > α, so it's self-locking. Now,* $T_R = F(d_m/2)\tan(\alpha+\varphi) = 10000 * (0.03/2) * \tan(3.03° + 5.71°)$. $d_m/2 = 0.015$ *m. α+φ ≈ 8.74°, tan ≈ 0.153.*

So $T_R \approx 10000 * 0.015 * 0.153 = 22.95$ *N·m. Next collar* $T_c = F(d_c/2)\mu_c = 10000 * (0.02)0.05 = 10$ N·m. So total torque ≈ 32.95 N·m. Efficiency = $Fl/\left(2\pi(T_R + T_c)\right) = (100000.005)/[2\pi(32.95)]$. Numerator = 50 J. Denominator = $2\pi 32.95 \approx 207.0$ *J. Efficiency ≈ 0.2415 or 24.15%. If we ignored the collar, efficiency would have been* $50/(2\pi 22.95) = 34.7$. So that collar ate about 10 percentage points of efficiency (makes sense, almost one-third of the torque was from the collar).

On the exam, you may not need to go through all those steps if they give you intermediate info. For example, they might directly say "efficiency = 25%" or give you the torque and ask for efficiency. Or conversely, give efficiency and ask for torque. It's straightforward algebra: $\eta = \frac{Fl}{2\pi T}$ can be rearranged to $T = \frac{Fl}{2\pi\eta}$. Just be cautious of units (use consistent ones as always).

Finally, a note on interpreting efficiency: A low efficiency is not always bad – it means the screw is self-locking (which can be good for safety). A high efficiency screw might save energy or allow faster motion, but it might require brakes. So in design, there's a balance. But for exam problem-solving, if they ask "what's the efficiency" you just compute it. If they ask something like "why use a square thread over a ball screw in a jack?", an answer might be "because square threads can be self-locking albeit at lower efficiency, whereas ball screws are efficient but not self-locking." Understanding that trade-off can sometimes illuminate what a question is really about.

K14.T07.S04 – Torque to Lower a Load (and Effect of Thread Friction)

Principle Introduction: Lowering a load with a power screw can be a very different scenario from raising it. In raising, friction works against you, making you put in extra torque. In lowering, friction can actually **work for you** by resisting the load's tendency to drop – up to a point. If the screw is self-locking, you need to apply a positive torque (in the reverse direction) to overcome friction and lower the load at a controlled rate. If the screw is not self-locking (overhauling), the load will try to spin the screw on its own – in that case you might have to apply a **braking torque** to keep the descent under control, or the load will come down rapidly. The formula for the torque to lower the load, T_L, looks similar to the raising formula but with a crucial sign change in the friction term. Essentially, for lowering, friction and gravity are now partially opposed: friction is helping keep the load up. We express this as $T_L = F\frac{d_m}{2}\tan(\varphi - \alpha)$ for a self-locking case. If $\varphi < \alpha$, then $\tan(\varphi - \alpha)$ is negative – indicating the screw will overhaul (turn by itself) unless held back. Let's delve into how to use this formula and what it means for different conditions.

Exam Handbook Search Cues (Not affiliated with or endorsed by NCEES): *power screws; lower load torque; friction aiding vs opposing; overhauling*

Equation Passport: Lowering Torque (Square-Thread Screw) – computes the torque required to **lower** a load in a controlled way using a square-thread screw, including the effect of thread friction which may reduce the needed torque.

Equation (lower load): $T_L = F\frac{d_m}{2}\tan(\varphi - \alpha)$

This formula gives the magnitude of torque required to **lower** the load at constant speed. Note: T_L here is considered positive in the sense of the torque you must apply *in the lowering direction*. For a self-locking screw ($\varphi > \alpha$), $\varphi - \alpha$ is positive, so T_L is a positive number – meaning you do have to apply a torque to make it descend. If $\varphi = \alpha$, $\tan(\varphi - \alpha) = 0$, so ideally no torque is needed to keep it moving (neutral equilibrium). If $\varphi < \alpha$ (overhauling), $\tan(\varphi - \alpha)$ is negative – this indicates that the weight will turn the screw without any applied torque (in fact, you'd need to apply a **resisting** torque to brake it, which is not captured by this formula's sign convention).

Variables and Units: *(All the same players as in the raising torque equation, but application differs)*

F – load force [N or lb_f].
d_m – mean thread diameter [m or in].
α – lead angle of thread [rad or °].
μ, φ – coefficient of thread friction, and friction angle with $\tan\varphi = \mu$ *(same μ as before).*
*T_L – torque to lower the load at steady speed [N·m or lb_f·ft]. If this comes out negative from calculation, it means no driving torque is needed – rather the load produces torque. In our usage we'll take T_L to mean the magnitude of torque you apply in the lowering direction** (so use the formula with the understanding that if $\varphi < \alpha$ you'll get a negative and interpret it accordingly).

Assumptions and Scope:

– The screw is moving at constant, slow speed downward (static or kinetic friction acting similarly). We assume no inertial effects (you're not letting it drop fast and then braking suddenly – that's beyond static analysis).

– This formula, like the raising one, assumes a square thread and no other losses. Collar friction could be added similarly: for lowering, the collar friction still opposes motion (it will actually **assist** in slowing the descent, meaning you have to overcome collar friction in the opposite direction to lower). If including collar friction, the total torque to lower (if self-locking) would be $T_{L,\text{total}} = F\frac{d_m}{2}\tan(\varphi - \alpha) + F\frac{d_c}{2}\mu_c$. Interestingly, for an overhauling screw, the collar friction might be the only thing preventing a free-fall, but that's not usually relied on.

– We consider T_L positive in magnitude for the direction that causes lowering. Often, in sign convention, raising torque might be considered positive clockwise, lowering counterclockwise, etc., but the exam won't dive into that—just give the required torque magnitude and maybe indicate the direction reversed.

– As always, units must be consistent. If using the angle form, keep angle units consistent.

Limit Tests:

– *Check self-locking scenario:* If the screw from earlier had $\varphi > \alpha$, plug in numbers: say α = 3°, φ = 6°, then φ - α = 3°. tan3° ≈ 0.052. If $F = 10$ kN and $d_m = 30$ mm as before, $T_L = 10000 * 0.015 * 0.052 \approx 7.8$ N·m. Compare that to raising torque (which was ~23 N·m in our prior calc). So indeed, much less torque is needed to lower than to raise – friction is doing some of the work for you (but you still need to turn it, just with less effort).

– *Borderline case:* If φ = α, $\tan(\varphi - \alpha) = 0$, so $T_L = 0$. That implies if you get it moving, it would keep going on its own at constant speed with no input. In reality, due to inertia and dynamic friction differences, you might still need a tiny push or brake, but ideal theory says neutral. The exam likely won't give exactly equal values due to precision.

– *Overhauling case:* If α = 6°, φ = 3° (i.e. μ smaller than tan6° ~ 0.105), then φ - α = -3°. $\tan(-3°) = -0.052$. If you compute T_L you get a negative number (e.g. -7.8 N·m in magnitude). This means if you try to *apply a torque in the lowering direction*, you'd actually be aiding an already eager load – not necessary. Instead, the load itself can supply up to 7.8 N·m of torque driving the screw. In practice, you'd apply a braking torque of 7.8 N·m in the **opposite** direction to restrain the motion. The formula's sign just alerts you to this condition.

Use vs. Sibling Equations: Use this T_L equation when dealing with **descending motion** of the load. It's the counterpart to the raising torque formula T_R. Do not confuse T_L with T_R – they are not the same (unless friction is zero, in which case $\varphi = 0$ and $T_L = T_R$ since $\tan(\varphi - \alpha) = \tan(-\alpha) = -\tan\alpha$, meaning you'd get same magnitude but opposite sign requirement – a frictionless screw needs the same effort up or down, just opposite direction). On the exam, if a question asks for "torque required to lower the load at constant speed," they expect you to either recall this formula or reason it out by reversing friction direction. **Do not** use the raising formula for a lowering scenario without adjusting the sign of friction term – that's a common mistake. Another related equation is the **self-locking condition** (tan α < μ) – essentially, if that holds, this formula gives a positive result; if not, you have an overhauling scenario. So checking the sign of T_L can double as a self-lock test (but it's easier to just compare tan α and μ directly).

Common Exam Traps:

– **Applying the wrong sign:** Many students memorize the raising formula and might just plug in values for lowering without thinking. For lowering, if you inadvertently use $T = F\frac{d_m}{2}\tan(\alpha + \varphi)$, you'll get a too-large number. Remember, when lowering, friction helps you – so it's $\varphi - \alpha$ in the tan. A good way to remember: for raising, friction and incline work together to make it harder (thus plus); for lowering, friction opposes the motion of the load (which is trying to go down), thus *reducing* the needed effort (thus minus).

– **Forgetting to consider overhauling:** On a problem where μ is small or α is large, T_L might come out negative (meaning no torque needed to go down). If you blindly take the absolute and say "Torque = 5 N·m to lower," you missed the conceptual point that actually it would back-drive. If the question is conceptual, they might expect the answer "No torque is required to initiate lowering; in fact the load will descend on its own (the screw is overhauling)." If it's numerical, they might frame it as "what magnitude of torque must be applied *to restrain* the load?" in which case you'd give a positive braking torque value. Read carefully.

– **Collar friction direction:** If you include collar friction in a lowering problem, be mindful of its effect. The collar friction always resists rotation relative to the load's motion. When raising, it made it harder (added torque required). When lowering, the collar friction still acts against the motion (which is now opposite direction), so you still have to overcome that friction in the lowering direction. That means you **add** the collar term when computing the torque to lower as well. Some might think "friction helps so maybe subtract the collar?" – no, the collar's friction is not helping hold the load up; it's actually another source of resistance you need to overcome to turn the screw *to make it go down*. So $T_{L,\text{total}} = T_L + T_c$ (same addition as before for magnitudes). The difference is, if the screw is overhauling, the collar friction might be the only thing slowing it – in that case, you'd say the net driving torque from the load is partially offset by collar friction.

– **Units and interpretation:** No new units issues beyond what we've hammered: keep consistent units. But interpretation-wise, be careful with wording: "torque required to lower" implies a positive effort you apply in the lowering direction. If the answer you find is negative, the correct interpretation is "no positive torque is required; instead the load will turn the screw." In an exam answer, you might phrase that as "0 N·m (the load will descend without torque, i.e. it's not self-locking)" if multiple choice allows, or select an answer like "the screw will rotate on its own". They might also ask, conversely, "what resisting torque must be applied to keep a safe lowering speed?" – that would be the absolute value of that negative result.

Footnotes: [1] When dealing with a negative T_L scenario, we often just say "the screw will back-drive." The exam might not require a numeric answer in that case, but rather a statement. If a numeric answer is expected, giving a negative value would imply direction (some exam grading might accept a negative to show that, but usually they expect you to realize and state it qualitatively). [2] The term "overhauling" can appear in questions. If they ask "Is this screw overhauling under the given conditions?", they're effectively asking if $\tan\alpha > \mu$. You could answer yes or no, but you could also reference the torque: "Yes, because the torque to lower would be negative, meaning the load overcomes friction." [3] Real-life note: Overhauling isn't always bad – for example, in an automotive jack you don't want it, but in a feed screw for a machine, you might want easier reversibility. However, on the FE, safety-critical devices (jacks, presses) are assumed to be self-locking unless they explicitly frame a scenario otherwise.

Variations and Additional Insights:

- **With collar friction:** As mentioned, include T_c similarly: $T_{L,\text{total}} = F\frac{d_m}{2}\tan(\varphi - \alpha) + F\frac{d_c}{2}\mu_c$. If $\tan(\varphi - \alpha)$ is negative (overhauling threads), the collar term might reduce the net driving tendency. In an extreme case, it's possible (though unusual) that thread friction alone isn't enough to lock, but adding collar friction could make the system hold. But relying on collar friction for self-locking is risky because if the screw unthreads a bit, the collar might lose pressure. The exam likely won't go that deep, but be prepared for maybe a conceptual twist like that.

- **Emergency lowering considerations:** In some designs, if a screw is self-locking, you might have to actively turn it to lower which can be slow. If it's not self-locking, you need a brake. Understanding which case you're in is critical. Some exam problems might indirectly test this by asking something like "This motor-driven screw must hold a load when power is off; should the screw have a lead angle of 2° or 10° given a friction coefficient of X?" The answer would hinge on self-locking: choose the smaller angle for self-locking if needed.

- **Alternate form of formula:** Just as raising had a fraction form, lowering can be expressed in terms of l, dm, μ: $T_L = F\frac{d_m}{2}\frac{\pi\mu d_m - l}{\pi d_m + \mu l}$. It's basically the mirror image of the raising formula fraction. You don't need to memorize that if you keep the tan form straight, but it's good to know it exists. It might appear in the reference or a solution. The sign of the numerator here, $(\pi\mu d_m - l)$, determines the sign of T_L. If $\pi\mu d_m < l$, then T_L computed from that would be negative (overhauling). If $\pi\mu d_m > l$, it's positive (self-locking). That again is the same condition.

- **Typical values scenario:** Let's revisit the earlier numerical example in raising but now for lowering: With $F = 10$ kN, $d_m = 30$ mm, $l = 5$ mm, μ=0.1 (φ ~5.7°), we found $T_R \approx 23$ N·m, $T_L \approx 7.8$ N·m (plus collar friction if any). If μ were only 0.05 (φ ~2.9°)

with the same screw (α ~3°), then $\tan(\varphi - \alpha) = \tan(-0.1°) - 0.0017$ (essentially zero). That means barely overhauling – the screw would almost neutral, just on the verge of overhauling. If μ drops to 0.03 (φ ~1.72°), then φ - α ~ -1.3°, $\tan(-1.3°) - 0.0227$, $T_L - 3.4$ N·m. The load will strongly try to spin the screw. These are small torques but remember the direction. So typical jack screws are designed not to reach that point under normal conditions.

- **Overhauling with mechanical advantage:** One interesting point: even if a screw is overhauling, it still provides mechanical advantage in speed – the load won't drop like a stone, it still must rotate the screw many times to come down a distance. But it means it can do so with its own weight providing the energy. That mechanical advantage (like 20 turns to drop an inch) can slow the fall somewhat, but it will still fall if unrestrained. In exam context, just identify if an external torque is needed or not.

Special Notes: If you're asked to compute a **braking torque** to *prevent* a load from descending too fast or to hold it, that's effectively the opposite of T_L. For an overhauling screw, the braking torque required to just hold it in place is equal in magnitude to the negative T_L (i.e., if T_L came out -5 N·m, a +5 N·m in the opposite direction would hold it). If you wanted to lower slowly, you might apply slightly less than that to let it turn slowly. The FE Exam likely won't get into that dynamic nuance, but conceptually: required driving torque for lowering = max(0, that formula result). If the formula gives a negative, 0 torque is required to initiate motion; any further negative indicates how much of a **resistive** torque you'd need to apply to keep it from accelerating. So you might answer those by saying "the load will descend on its own; apply a counter-torque of X to control it if needed."

Explanation & Analysis: Let's tie this together. We derived earlier that $T_R = F\frac{d_m}{2}\tan(\alpha + \varphi)$ by considering forces on the incline (thread) going **upwards**. If we consider the forces for downward motion, gravity is now "helping" the motion and friction is partially opposing it. The net force needed along the thread is the difference between the downhill component and friction. On the incline analogy: downhill component of weight = $F\tan\alpha$ (wants to make the nut slide down), friction max static = $F\tan\varphi$ (resisting slide). If $F\tan\alpha$ is smaller, friction can hold it (self-locking). If we want to lower at steady speed, we actually need to overcome that friction in the opposite direction (essentially pull the nut **down** against friction). The force needed along the plane to keep a constant speed down is $F\tan\alpha - F\tan\varphi$ (weight component minus friction, assuming weight component is bigger in an overhauling scenario). If friction is bigger (self-locking), then you actually need to push *down* a bit: in that case the expression $F(\tan\varphi - \tan\alpha)$ is positive and that is the force needed to overcome static friction to start moving down. Multiply that force by the radius $d_m/2$ and you get T_L. In formula terms, that becomes $T_L = F\frac{d_m}{2}\tan(\varphi - \alpha)$ for the self-locking case where $\varphi - \alpha$ is positive. That matches our given formula. If the screw is right at the edge, φ - α = 0, no net force needed (balance). If overhauling, φ - α is negative, meaning weight exceeds friction; friction is not enough to hold it, and in fact, you'd have to *hold back* instead of drive.

In simple terms: **When lowering a heavy load, friction is your friend.** It reduces how much you have to do. The extreme of that is you doing nothing (or even having to hold it back) if friction isn't high enough to lock it. On exam problems, after computing T_L you should interpret it: if you get a positive number, that's the torque you must apply (likely the answer if they asked for it). If you get a negative, the proper response is likely explaining that the screw will self-move. They might even specifically ask, "Will this screw require a driving torque to lower the load?" – you'd answer "No, it will actually back-drive (overhaul) due to insufficient friction."

Also, notice that lowering torque being less than raising torque is expected whenever there's friction. For a self-locking screw, raising might be tough (say 50 N·m) while lowering might be easy (maybe 10 N·m needed to overcome stiction and then keep it going). If you ever screwed down a large vise or press, you might recall it takes effort to lift something, but lowering it you still have to turn the handle – it doesn't just drop – though it might feel lighter. That's exactly this situation.

To apply this formula, follow a similar pattern as for raising: identify F (weight), d_m (mean diameter), compute or get α (lead angle from geometry), get μ (giving φ via arctan). Then plug into $T_L = F(d_m/2)\tan(\varphi - \alpha)$. If $\varphi < \alpha$, you'll end up taking tan of a negative angle – better to calculate $\varphi - \alpha$ as a number (could be negative), take tan of that (you'll get a negative result), and interpret accordingly. Alternatively, some prefer to always do $\tan|\varphi - \alpha|$ for magnitude and then think about direction separately. Just be careful: the sign *does* carry meaning.

In sum, thread friction makes it easier to lower a load than to raise it, up until the point that you might not have to input any torque at all (the load does the work). The FE Exam wants you to understand both ends of this spectrum: **self-locking** screws (you must drive it both up and down) vs **overhauling** screws (you drive it up, but it comes down on its own). With the formulas for T_R and T_L in hand, you can quantitatively determine which case you have and how much torque is involved in each direction. Always double-check: does your answer make sense physically? If you found it takes more torque to lower than to raise, something's off (unless maybe you included a huge collar friction for lowering only, but that's unlikely – the symmetry of physics says lowering should be easier or equal at worst).

By mastering these relationships, you'll be able to confidently tackle any power screw question the FE throws at you. Whether it's calculating that input torque, determining efficiency, or ensuring the screw won't slip, it all boils down to understanding the role of friction and thread geometry in these equations. Practice a couple of scenarios with different μ and α to get a feel, and you'll have this topic **screwed down tight** (so to speak)!

Topic 08 - Power Transmission

Topic Overview: The Power Transmission topic in the FE Mechanical Exam covers how mechanical power is conveyed between machine components. This includes designing rotating shafts and keys, gears and gear trains, and belt or chain drives. On exam day, expect tasks like "Given a torque and allowable shear stress, compute the required shaft diameter," or "For a gear train, find the output speed and torque."

Understanding Power Transmission means knowing how to apply these core ideas: - **Torque and torsion:** how a twisting moment T produces shear stress τ in a shaft. - **Keys:** how to size a key to carry a given torque without exceeding shear or bearing stress. - **Gear ratios:** relating input/output speeds and torques through gear teeth counts. - **Belt/chain drives:** computing tensions and transmitted power in pulley or sprocket systems. - **Belt friction (capstan):** how wrap angle θ and friction μ affect the tension ratio on a pulley.

By mastering these concepts and formulas, you can handle questions like *"Calculate the minimum shaft diameter," "Determine the gear train speed ratio,"* or *"Compute belt tensions given power."* Each subtopic below focuses on one core formula or rule essential for solving these problems.

K14.T08.S01 - Shafts and keys

Principle: A solid circular shaft under an applied torque T develops a shear stress τ given by the torsion formula $\tau = Tr/J$. For a solid shaft, $J = \pi d^4/32$, yielding $\tau = \frac{16T}{\pi d^3}$. On the FE exam, a common problem is: *"Given torque T and allowable τ, find the required diameter d."* This comes straight from rearranging $T = \frac{\pi}{16}\tau d^3$.

Equation Passport: *Circular Shaft Torsion* – computes shaft diameter or shear stress under torque.

$$T = \frac{\pi}{16}\,\tau\, d^3.$$

- **Variables & units:** T = torque (N·m), τ = shear stress (Pa), d = shaft diameter (m).

- **Assumptions:** Shaft is straight, solid, circular, and only torsion is considered (no bending or axial load). Material is elastic. Use consistent units throughout.

- **Limit tests:** As $T \to 0$, $d \to 0$ (zero torque needs no shaft). As $\tau \to 0$, $d \to \infty$ (zero strength is impossible). These checks catch sign or unit errors (e.g., negative inputs or mixing N·m with lbf·ft).

- **Use vs sibling:** Use this formula when a shaft transmits torque. Do **not** use bending or axial formulas here.

- **Common exam traps:** Mixing up radius vs diameter in the formula (remember it's d^3). Forgetting unit conversions (e.g. torque in N·m but τ in MPa). Using the wrong value for allowable shear (convert psi to Pa if needed).

Keywords: *torsion, shaft, polar moment, shear stress, diameter* (search the exam handbook for shaft torsion formulas).

Footnotes: - Use SI units: 1 MPa = 10^6 Pa. For example, 80 MPa = 80×10^6 Pa.
- τ is the maximum shear at the shaft surface (outer fiber).
- In US units: 1 lbf·ft = 1.356 N·m, 1 psi = 6895 Pa (you must include the conversion factor g_c if mixing lbm and lbf).

Variations: A hollow shaft has a different J (subtract inner d^4). The exam usually only asks solid shafts. For **keys**, torque is transferred via shear or bearing: roughly $T = \tau_s(2bL)(d/2)$ for shear (two shear planes of area bL), or $T = \sigma_p(hL)(d/2)$ for bearing (area hL). Solve for key length L ensuring neither shear stress τ_s nor bearing stress σ_p is exceeded. These key formulas are seldom directly tested but understanding that $T = F \times (d/2)$ with F = force on the key is helpful.

Special Notes: On calculators, solve d by taking the cube root: e.g. compute $\left(16T/(\pi\tau)\right)^{1/3}$. Most scientific calculators have an $x^{1/3}$ or root function. Always check your unit consistency before finalizing the answer (e.g., torque in N·m and stress in N/m^2 gives d in meters).

Explanation & analysis: To design the shaft, start from $T = \frac{\pi}{16}\tau d^3$. Rearrange to $d = \sqrt[3]{\frac{16T}{\pi\tau}}$. For example, if $T = 500$ N·m and $\tau_{\text{allow}} = 80$ MPa: plug in $T = 500$, $\tau = 80 \times 10^6$ Pa, calculate d. Make sure d comes out in meters (multiply by 1000 for mm if needed). Each symbol: T is the twisting moment on the shaft; τ is the allowable shear stress of the material; d is what we solve for. A frequent error is inserting diameter when formula expects radius or vice versa – here d is diameter in meters. After solving, **round up** to the next practical size to ensure safety.

K14.T08.S02 - Gears and gear trains

Principle: Gears transmit motion with an input speed ω_{in} and output speed ω_{out}. The relation (velocity ratio) for two meshing gears is

$$\frac{\omega_{\text{out}}}{\omega_{\text{in}}} = -\frac{N_{\text{in}}}{N_{\text{out}}},$$

where N = number of teeth. The negative sign indicates reversal of direction. Torque follows the inverse ratio: $\frac{T_{\text{out}}}{T_{\text{in}}} = \frac{N_{\text{out}}}{N_{\text{in}}}$. For example, a 20-tooth pinion driving a 40-tooth gear: $\omega_{\text{out}}/\omega_{\text{in}} = 20/40 = 1/2$ (output is half the input speed, opposite direction) and $T_{\text{out}} = 2T_{\text{in}}$.

Equation Passport: *Gear Train Ratio* – relates output speed and torque to input.

$$\frac{\omega_{\text{out}}}{\omega_{\text{in}}} = \pm\frac{N_{\text{in}}}{N_{\text{out}}}, \qquad \frac{T_{\text{out}}}{T_{\text{in}}} = \frac{N_{\text{out}}}{N_{\text{in}}}$$

- **Variables & units:** ω = angular velocity (rad/s or rpm), T = torque (N·m), N = number of gear teeth (–). If using rpm for speeds, it cancels in the ratio.

- **Assumptions:** Gears mesh perfectly (no slip). A higher tooth count means a larger gear. Negative speed ratio means output reverses direction (just take the magnitude if direction is not asked).

- **Limit tests:** If $N_{\text{in}} = N_{\text{out}}$, then $\omega_{\text{out}} = \omega_{\text{in}}$ and $T_{\text{out}} = T_{\text{in}}$ (1:1). If $N_{\text{out}} \gg N_{\text{in}}$, then $\omega_{\text{out}} \ll \omega_{\text{in}}$ (much slower) and $T_{\text{out}} \gg T_{\text{in}}$ (torque amplified). Use these to verify your answer.

- **Use vs sibling:** Use this for direct gear meshes. For belt or chain drives, an analogous ratio is $D_{\text{in}}/D_{\text{out}}$ (pulley diameters).

- **Common exam traps:** Swapping input/output gear counts. Forgetting to account for direction (negative sign). For compound trains (multiple gear pairs), multiply stage ratios, not add.

Keywords: *gear ratio, velocity ratio, gear train, number of teeth*.

Footnotes:

- If speeds are given in rpm, you can compute ratio directly (units cancel).
- Torque multiplies oppositely: e.g. half speed means double torque (assuming ideal gears).
- For compound gears: if Gear1 (input) drives Gear2 on same shaft as Gear3 driving Gear4 (output), the overall ratio = $\frac{N_1}{N_2} \times \frac{N_3}{N_4}$.

Variations: For a two-gear pair: $\omega_2 = \omega_1(N_1/N_2)$. For a chain drive, use the number of teeth on sprockets similarly. Sometimes power P is given: recall $P = T\omega$ (so $T = P/\omega$) if needed. If the question involves finding power, compute one speed/torque first, then use P.

Special Notes: No special calculator modes needed. Perform fraction multiplications carefully. If teeth counts are large, simplify the ratio if possible (e.g. $30/90 = 1/3$).

Explanation & analysis: Suppose gear A (driver) has 15 teeth, gear B (driven) has 45, and $\omega_A = 1800$ rpm. Then $\omega_B = \omega_A \times (15/45) = 600$ rpm. The torque ratio is $T_B = T_A \times (45/15) = 3T_A$. In symbols: $N_{\text{in}} = 15$, $N_{\text{out}} = 45$. Check it makes sense: output is slower but stronger. Always label which gear is input vs output; it's easy to reverse them by mistake. If in doubt, use the power check $T_{\text{in}}\omega_{\text{in}} = T_{\text{out}}\omega_{\text{out}}$ (neglecting sign) to verify consistency.

K14.T08.S03 - Belt and chain drives

Principle: Belts and chains transmit power through a tension difference. In an open belt drive, let T_t = tight-side tension, T_s = slack-side tension, and v = belt speed (m/s). The transmitted power is

$$P = (T_t - T_s)\, v.$$

No-slip means $v = \omega R$ (with R = pulley radius) or $v = \pi D\, n/60$ (with diameter D in m and speed n in rpm). Essentially, the net force $(T_t - T_s)$ moves at velocity v.

Equation Passport: *Belt Drive Power* – computes transmitted power from tension difference.

$$P = (T_t - T_s)\, v.$$

- **Variables & units:** P = power (W), T_t, T_s = tensions (N), v = belt speed (m/s). (To find v: e.g. $v = \pi D\, n/60$.)

- **Assumptions:** Steady motion, no belt slip, uniform tension on each side. Chain drives are analogous (chain slack vs tight side).

- **Limit tests:** If $T_t = T_s$, then $P = 0$ (no net force → no power). If $v = 0$ (shaft locked), $P = 0$. Ensure unit consistency (N·m/s = W).

- **Use vs sibling:** Use this when given belt tensions or asked for power. If given P and v, solve $T_t - T_s = P/v$. For gears, use the gear ratio instead.

- **Common exam traps:** Converting rpm to m/s incorrectly (ω to v). Forgetting that $T_t > T_s$. Mixing SI and US units. If an *initial tension* T_0 is involved, remember $T_t + T_s = 2T_0$ for an open belt.

Keywords: *belt tension, tight side, slack side, power, no-slip*.

Footnotes:

- Convert pulley diameter D to radius $R = D/2$ for $v = \omega R$.
- In kW problems, 1 kW = 1000 W.
- For chain drives, use the same formula (just treat sprockets like pulleys).

Variations: For an *initial tension* problem: if T_0 is given, use $T_t = T_0 + \Delta$, $T_s = T_0 - \Delta$, and $T_t - T_s = 2\Delta = P/v$. Solve the two equations $T_t + T_s = 2T_0$ and $T_t - T_s = 2\Delta$. For a *crossed belt* (twisting direction), the same power formula holds but remember wrap angle may differ.

Special Notes: On calculators, compute v first. Example sequence: $v = \pi D n/60$ then $(T_t - T_s) = P/v$. Watch out: n in rpm must be /60, D in meters. No special functions beyond π and division.

Explanation & analysis: Example: A motor at 1200 rpm drives a 0.25 m pulley, transmitting $P = 6$ kW. First, $v = \pi(0.25)(1200/60) = 15.71$ m/s. Then $T_t - T_s = P/v = 6000/15.71 \approx 382$ N. If the problem also gives an initial tension T_0, say 500 N, then $T_t + T_s = 1000$ N. Solve $T_t - T_s = 382$ and $T_t + T_s = 1000$: $T_t = 691$ N, $T_s = 309$ N. Each symbol: T_t is the larger tension pulling the belt, T_s the smaller returning tension. A quick check: $(691 - 309) \times 15.71 \approx 6000$ W, as required.

K14.T08.S04 - Belt friction (capstan equation)

Principle: When a belt or rope wraps around a pulley, friction allows a high-tension ratio. The *capstan equation* is

$$T_{\text{tight}} = T_{\text{slack}}\, e^{\mu\theta},$$

where T_{tight} = tight-side tension, T_{slack} = slack-side tension, μ = static friction coefficient, and θ = wrap angle (rad). For instance, a 180° wrap is $\theta = \pi$.

Equation Passport: *Capstan (Belt Friction) Equation* – gives tension amplification from wrap angle.

$$T_t = T_s \exp(\mu\, \theta).$$

- **Variables & units:** T_t, T_s = belt tensions (N), μ = coefficient of friction (–), θ = contact angle (rad).

- **Assumptions:** Static (impending slip) friction, uniform pressure. Use the static μ. The formula assumes no slip yet (belt on verge of slipping).

- **Limit tests:** If $\mu = 0$ or $\theta = 0$, then $T_t = T_s$ (no friction or no wrap). As $\mu\theta$ grows, T_t increases exponentially. This checks direction and magnitude intuitively.

- **Use vs sibling:** Use this when belt/rope friction around a pulley matters (e.g. "at what tension will the belt slip?"). Do **not** use for smooth pulleys or unrelated friction problems.

- **Common exam traps:** Mixing degrees and radians (always convert: $1° = 0.01745$ rad). Using kinetic instead of static μ. Swapping tight/slack tensions. Always ensure $T_t \geq T_s$.

Keywords: *belt friction, capstan, wrap angle, friction coefficient*.

Footnotes:

- The equation derives from $\ln(T_t/T_s) = \mu\theta$.
- Always use θ in radians in the calculation.
- If values are in lbf, convert μ appropriately or stay consistent with units.

Variations: For multiple pulleys, apply the formula on each wrap. In a locking problem (max torque before slip), find T_t from this and then torque.

Special Notes: Use the calculator's exp function. For example, $\exp(\mu\theta)$ is straightforward. If only ln is available: compute $\ln(T_t/T_s) = \mu\theta$. Be careful with large $\mu\theta$ (e.g. >3 gives big tension ratios).

Explanation & analysis: Compute the tension ratio first. For example, $\mu = 0.3$, $\theta = 2.5$ rad: $e^{0.3\times2.5} = e^{0.75} \approx 2.12$. If $T_s = 100$ N, then $T_t = 2.12 \times 100 = 212$ N. The resulting torque on a pulley of radius R would be $T = (T_t - T_s)R = (212 - 100)R$ (N·m). Check each symbol: μ from a reference (e.g. rubber on steel), θ in rad, T_t is the larger tension. A common mistake is forgetting radian measure or labeling the wrong side as tight. Always verify $T_t/T_s = e^{\mu\theta}$ holds with your values.

Summary: We covered the essential power-transmission tools: torsion formulas for shafts, gear ratios for gear trains, belt tension and power relations, and the capstan equation for friction. On exam day, match the right equation to the scenario (shaft torsion, key shear, gear speed ratio, belt power, or belt friction) and keep your units consistent. With these passports, you have the core formulas and checks ready to tackle any power transmission problem.

Topic 09 - Joining Methods

Joining methods cover how separate parts are fastened together, including mechanical fasteners (bolts, screws), welded joints, and adhesives. These methods determine how forces are transmitted across connections and are critical in design problems on the FE Mechanical Exam. Typical exam questions give a joint (for example, a bolted flange or a welded connection) and ask you to compute bolt loads, member stresses, or verify joint strength. Mastering *Joining Methods* means knowing how preload and external loads split between fasteners and parts, how to check failure modes (tensile, shear, thread stripping), how weld geometry affects strength, and when adhesives are appropriate. This topic appears under "mechanical design" problems, often disguised within structural or machine design scenarios.

K14.T09.S01 – Threaded Fasteners (Bolts and Screws)

- **Core idea:** Bolt preload (clamping force) combined with external loads; members and bolt act like springs in parallel.
- **Key facts:** Bolts are often pre-tensioned to clamp parts; under external tension, the additional load splits between the bolt and the members based on their stiffnesses.
- **Why it matters:** On exam day, you might be given a flanged joint and asked, for example, "What tensile load does the bolt carry when the external load is applied?" or "Will the joint separate under load?".
- **Questions:** Typical tasks include finding the bolt force F_b and the clamped-member force F_m for a given preload F_i and applied load P.

Equation Passport – Bolt Load Sharing (Parallel-Spring Model). Computes how an external tensile load is shared between the bolt and clamped members.

$$F_b = C\,P + F_i, \qquad F_m = (1 - C)\,P - F_i,$$

where

- F_b = total load in bolt (force in tension, units N or lbf).
- F_i = bolt preload (initial clamp force, N or lbf).
- P = externally applied tensile load (N or lbf; positive in tension).
- F_m = total load absorbed by the members (force in tension/compression, N or lbf; note sign conventions).
- $C = \frac{k_b}{k_b + k_m}$ = joint stiffness factor (dimensionless).
- k_b, k_m = effective stiffness of bolt and members (N/m or lbf/in): see analysis below.

Assumptions: Linear-elastic behavior, small deflections, constant stiffness, parts remain within elastic limits. The formula applies to axial loading only (no bending on joint). *Scope:* Used for basic bolted joint analysis in static equilibrium. Excludes dynamic effects (fatigue), and ignores relaxation or gasket effects (unless included in k_m).

Limit tests: If $P = 0$ (no external load), then $F_b = F_i$ and $F_m = -F_i$ (members see equal compressive force, bolt sees only preload) – as expected. If the joint is very stiff (members much stiffer than bolt, $k_m \gg k_b$), then $C \to 1$ and nearly all external load goes into the bolt. If the bolt is very stiff ($k_b \gg k_m$), then $C \to 0$ and nearly all load goes into the members. These checks help avoid sign or unit mistakes.

Use vs. siblings: Use this joint-load formula instead of assuming all external load goes into the bolt. If k_b and k_m are not known or when one component dominates stiffness, you might approximate $F_b \approx P + F_i$ (if bolt is much less stiff than members, so $C \approx 1$).

Common exam traps: Forgetting to include the preload F_i sign correctly (it's tensile in the bolt but compressive on members). Mixing up F_m sign (the formula above assumes F_m is positive when the members are in tension; many references write $F_m = (1 - C)P + F_i$ depending on sign convention). Not checking units (use consistent N or lbf everywhere). Overlooking that C depends on stiffnesses, not just material.

Exam Handbook Search Cues (Not affiliated with or endorsed by NCEES): *"bolt load sharing," "joint stiffness," "bolt preload," "joint coefficient," "bolt stiffness"* (these keywords lead to the bolt-load formulas in the exam handbook).

Footnotes: In U.S. units, be careful: lbf (force) vs lbm (mass). Conventionally we write forces in lbf, lengths in inches. The bolt diameter used for stress area A_t (next section) is the tensile stress area (approx area at root of threads). In equations above, F_i is treated as positive for tension (if bolt is pre-tensioned). The formula implicitly assumes pre-tension and load are colinear (axial).

Variations: In the simplified torque–preload relation $T = K\,F_i\,d$, the coefficient K is an empirical torque–preload parameter that depends strongly on friction conditions (threads, under-head/nut bearing surface), lubrication, coatings, and surface finish. For exam-style problems, use the K value provided by the problem statement or permitted reference. If a problem requires an assumption, state your assumed K explicitly rather than relying on a memorized "typical" number. For load sharing, the joint coefficient is $C = \frac{k_b}{k_b + k_m}$, where k_b is the effective bolt stiffness and k_m is the effective member stiffness in the load path. Compute stiffnesses from the geometry/material model specified by the problem/permitted reference, or use a provided C directly if the problem supplies it.

Special notes: On a TI or HP calculator, compute $C = k_b/(k_b + k_m)$ by entering numeric values of k_b and k_m. To enter $k_b = AE/L$ sum form, either sum with parentheses or use separate steps (no built-in bulk formula). Use units like N/m (SI) or lbf/in (USCS) consistently. The standard FE calculator (TI-36X etc.) cannot store symbolic formulas, so treat these as numerical inputs.

Explanation & Analysis: The formula above treats the bolt and clamped parts as two springs in parallel (both feel some of the applied force). The fraction C is the share of the external load P that the bolt sees, due to relative stiffness. Physically, a stiff bolt (small stretch per force) and flexible members (larger stretch) means the bolt picks up more load. The preload F_i adds a constant tensile offset in the bolt (and equal compressive offset in the members). On the FE exam, you often solve for F_b using $F_b = CP + F_i$, or for joint separation by checking if $F_i > (1 - C)P$.

Term-by-term: The joint coefficient is

$$\mathrm{C} = \frac{\mathrm{k_b}}{\mathrm{k_b} + \mathrm{k_m}},$$

where k_b is the effective bolt stiffness and k_m is the effective member stiffness. This comes from treating the bolt and members as springs that undergo the same joint displacement in the load direction.

Bolt stiffness (series segments): If the bolt has distinct segments that deform in series (e.g., unthreaded shank length l_d with area A_d, and threaded length l_t with tensile-stress area A_t), add compliances:

$$\frac{1}{k_b} = \frac{l_d}{A_d E} + \frac{l_t}{A_t E} \Rightarrow k_b = \left(\frac{l_d}{A_d E} + \frac{l_t}{A_t E}\right)^{-1}.$$

Member stiffness: For the clamped members, compute k_m using the geometry/material method specified by the problem or permitted reference (for multiple clamped layers, member compliances add in series). If the permitted reference provides an empirical joint-geometry stiffness model with coefficients, use that reference directly during problem solving rather than reproducing coefficient tables in this guide.

Finally, check consistency: if P increases, F_b and F_m both increase (linearly). If F_i is high, the bolt starts near its proof limit even with $P = 0$. Make sure not to exceed material strength: typically require $F_b < S_p A_t$ for safety (where S_p is proof strength, A_t tensile stress area). A quick safety-check formula given in the handbook (bolt load factor) is $n_b = (S_p A_t - F_i)/(CP)$, but often you just compare stresses directly.

K14.T09.S02 – Bolted Joint Failure Modes

- **Core idea:** Identify how a bolted connection can fail: bolt yield (tension/shear), member failure (rupture), or thread stripping.
- **Key facts:** The basic failure stress formulas are $\tau = F/A$ for shear and $\sigma = F/A$ for tension. In single-shear, a bolt loaded by shear fails when the shear stress τ exceeds the bolt's shear strength. In tension, either the bolt can yield or the plate can rupture (use the net area of the plate). Thread stripping occurs when the shear area of the thread in the weaker material (nut or hole) is insufficient.
- **Why it matters:** Exam problems will ask if a given bolt or plate fails under load. For example: "Given a bolt with a certain load, check if the bolt's shear stress $\tau = F/A$ or tensile stress $\sigma = F/A$ exceeds allowable." Or check if threads strip out of a plate.
- **Questions:** Typically compute stress and compare to allowable: e.g., "Calculate the tensile stress in the bolt and the bearing stress in the plate, then check vs. material limits."

Equation Passport – Stress in Fastener or Plate (Shear/Tension). Computes stress from force and area:

$$\tau = \frac{F}{A}, \qquad \sigma = \frac{F}{A},$$

- τ = shear stress in fastener (e.g. bolt shear, Pa or psi).
- σ = tensile stress in bolt or plate (Pa or psi).
- F = applied force (N or lbf; shear or tension as context).
- A = cross-sectional area resisting the force (m² or in²). For bolt shear, A is the bolt's cross-sectional area; for plate rupture, A is the **net** area of the thinnest plate minus any bolt holes.

Assumptions: Pure single-shear or direct tension, uniform stress distribution. For bolts in shear, assume single shear (if double shear, each shear plane carries half the load, effectively doubling area). *Scope:* Use for quick checks. Complex joint analysis (eccentric loads, fatigue, combined loads) is beyond this simple formula.

Limit tests: If $F = 0$, stress is zero (trivial). As $A \to 0$, stress $\to \infty$ – reminds you never to divide by zero (the net area should exclude holes!). If using SI units, F in newtons and A in m² yields Pa; in USCS, F in lbf and A in in² yields psi (often use ksi for steel).

Use vs. siblings: Use $\sigma = F/A$ rather than advanced formulas when dealing with simple direct loading. For shear in bolts, remember $\tau = F/A$. Do not confuse with beam formulas or fatigue formulas (those need different context).

Common exam traps: Mixing up net vs gross area: Always use net (hole-subtracted) area for plate rupture. Forgetting that bolt threads have reduced area A_t (for tensile checks, use the tensile stress area of the bolt, not full shank area). For shear in threaded bolts, you usually still use the bolt's shank area. Units mix-up: using in² vs mm². Ignoring double-shear: if a bolt is double-shear, remember each shear plane carries half the load (so total resisting area is doubled).

Exam Handbook Search Cues (Not affiliated with or endorsed by NCEES): *"fastener shear failure," "member rupture," "bolted joint shear," "tensile stress," "net area"* (the exam handbook charts show formulas for shear and tensile failure of bolts and plates).

Footnotes: Bolt threads: The tensile stress area A_t (for a given diameter and thread series) is listed in standard tables (often needed for pre-load calculations). Thread strip shear area: For a standard bolt in a plate, a rough rule is one full thread turn provides shear area $\pi d_n \times 1/n$ (where d_n is minor diameter, n threads per unit length). In practice, ensure at least one thread engages the material. The factor 0.577 sometimes appears in thread shear formulas (≈1/√3).

Variations: Bolt grades: Steel bolts have proof (often ~80% of ultimate tensile) and yield strengths (e.g., Grade 5 ~85 ksi yield, Grade 8 ~120 ksi yield in US units). These values appear on the FE exam handbook tables or are given in problems. Common pitfall: using ultimate instead of proof. Typical shear strength of a steel bolt is about 0.6–0.7× its tensile strength. Threads in softer material: You may assume the plate (nut) material is the limiting strength if it is weaker.

Special notes: In the allowed calculators, you might input $\tau = F/A$ directly as $F \div A$. Make sure to use correct area: e.g. if $d = 0.5$ in, bolt area = $\pi(0.5)^2/4 = 0.1963\ \text{in}^2$. When using metric, use mm^2 or convert to m^2. For thread minor diameter, you may need a reference (calipers, textbook); on exam, minor diameters are often given if needed.

Explanation & Analysis: The stress formulas simply state: stress = load divided by the cross-sectional area resisting the load. For shear in a fastener, picture cutting (like scissors) through the bolt shank. For a simple bolt in single shear under a force F, each bolt sees that shear, so $\tau = F/A_b$, where A_b is bolt cross-section (e.g. $\pi d^2/4$ or tensile area). For tensile failure of bolt or plate, $\sigma = F/A_{\text{net}}$. Examine each possible failure: **Bolt yield** (check $\sigma_b = F_t/A_t$ vs bolt yield or proof strength), **Plate rupture** ($\sigma_p = F_t/A_{\text{net}}$ vs plate tensile strength), **Bolt shear** ($\tau_b = F/A_b$ vs bolt shear yield), and

Crushing/bearing (pressure on plate around hole: $p = F/(dt)$ comparing to bearing strength).

Thread stripping: imagine the threads of the bolt or nut being sheared off. It occurs if the shear capacity of the engaged threads (in the nut/plate) is less than the tensile load. A rough check is comparing tensile stress in bolt vs shear stress in nut:

$$P_{strip} \approx 0.577\, \sigma_u\, \pi d_n L_{\text{eng}},$$

but the exam typically does not require this derivation. Instead, ensure sufficient engagement length (~1–2× bolt diameter for steel in mild steel).

In analysis problems, you'll calculate both bolt stress and member stress and pick the lowest failure load. For example, if a bolt is loaded with 10 kN in tension and its area is 20 mm², its tensile stress is $10{,}000/20 = 500$ MPa. If the bolt's yield is 400 MPa, it fails. Meanwhile, if the plate net area is 50 mm², plate stress is $10{,}000/50 = 200$ MPa; if plate yields at 250 MPa, the bolt governs. This systematic check ensures no mode is overlooked.

K14.T09.S03 – Welding

Core idea: Welding fuses materials at joints (e.g. fillet and butt welds); weld strength depends on weld geometry (throat area) and weld material properties.

Key facts:

- A **butt weld** (fusion weld) joins two pieces end-to-end; its cross-sectional area is essentially the same as the base material, so strength is like the parent material.
- A **fillet weld** is triangular cross-section (common for lap or T-joints); the *throat* is the effective strength-bearing thickness.
- **Why it matters:** Exam problems may ask for weld size given a shear load, or compare weld vs bolt. For example: "Determine leg size of fillet weld to carry a given shear load without exceeding allowable shear stress."
- **Questions:** Compute weld throat area and check against shear load. E.g., "A fillet weld of leg length a is loaded with P. What is the required a if shear strength is τ_w?"

Diagram Passport – Fillet Weld Geometry. (Sketch of fillet weld cross-section, with legs and throat labeled.)

A fillet weld is typically a right triangular weld of leg length a on each side. The *throat* t is $a/\sqrt{2}$ (for a 45° fillet). The effective shear area $A_{\text{throat}} = t \times L$, where L is the length of weld. For a double-sided weld, area doubles.

Symbol	Description	Units
a	fillet weld leg length (toe-to-root)	m or in
t	fillet weld throat thickness ($a/\sqrt{2}$)	m or in
L	length of weld (span of the weld line)	m or in
τ_w	allowable shear stress of weld (MPa or psi)	MPa or psi

Key regions: The critical area is the throat (shaded in diagram). For a symmetrical double fillet weld, each side carries half the load, but the total effective area is $2tL$.

Reading the weld: Given a, compute $t = a/\sqrt{2}$. Then $A_{\text{throat}} = t \times L$. Shear load P is resisted by shear stress $\tau = P/(A_{\text{throat}})$.

Common misreads: Using leg a instead of throat t in area, or forgetting the $\sqrt{2}$. Confusing single vs double fillet: a double fillet (V-joint) has twice the area of a single fillet of same a. Not considering weld length or incomplete penetration.

Equation Passport – Fillet Weld Throat Area. Computes effective cross-sectional area of a fillet weld in shear.

$$A_t = \frac{a\,L}{\sqrt{2}}$$

- A_t = throat area of fillet weld (m² or in²).
- a = leg length of weld (m or in).
- L = length of the weld (m or in).

Assumptions: 45° weld bevel (common fillet), uniform cross-section, complete penetration to throat. Applies to static shear loading only. *Scope:* Use when checking fillet weld strength in shear or shear+tension. For butt welds, one generally uses the full cross-section of base metal (no special formula).

Limit tests: If $a = 0$, $A_t = 0$ (no weld). If $a \to \infty$ (unrealistic), area $\to \infty$. If $L = 0$, $A_t = 0$. In practice, ensure a is large enough that $A_t\, \tau_w \geq P$.

Use vs. siblings: Use this throat-area method instead of naive $A = La$ (that would be area of full triangle instead of effective part). Do not confuse with butt welds (for butt welds, area = plate thickness × width).

Common exam traps: Omitting the $1/\sqrt{2}$ factor (overestimates strength by ~41%). Using metric leg a as if it were throat. Ignoring that a partial penetration or fillet around a corner might have less effective length.

Exam Handbook Search Cues (Not affiliated with or endorsed by NCEES): *"weld shear stress," "fillet weld throat area," "weld strength"* (though the FE handbook doesn't list this formula explicitly, these terms appear under welding or fastener topics).

Footnotes: Leg length a is measured from the root to the toe of the weld. Units must match: if a is in mm and L in mm, A_t in mm²; convert to m² or in² as needed. The weld metal shear strength τ_w is often given, or taken as about 0.6 times the weld's tensile strength (for steel).

Variations: For a **butt weld** (full penetration), the joint cross-section is simply the plate's cross-section; check stress as $\sigma = F/A_{\text{plate}}$. For a **groove weld** (deep butt weld), if not full penetration, sometimes an equivalent area using reinforcement is considered, but this is advanced. Weld material: assume weld metal strength similar to base metal unless specified otherwise.

Special notes: In calculators, use $\sqrt{2}$ or 1.414. If the calculator has no √ key for constants, remember 1.4142 as an approximation for $\sqrt{2}$. You may input $A_t = a * L/1.4142$. The FE calculator cannot solve symbolic square roots, so treat as number. Always label whether stress τ_w is shear (units MPa or psi).

Explanation & Analysis: Fillet welds carry loads through shear on the throat area. For example, if a fillet weld has leg $a = 6$ mm and length $L = 50$ mm, its throat thickness is $t = 6/\sqrt{2} = 4.24$ mm, so area $A_t = 4.24 \times 50 = 212$ mm². If the shear load is $P = 30$ kN, the shear stress in the weld is $\tau = 30{,}000/212 \approx 141$ MPa. We then compare this to allowable weld shear (say $\sigma_{\text{allow}} \approx 150$ MPa), and find it's safe.

Butt welds, by contrast, join the full cross-section: e.g., welding two 10 mm plates gives the same 10 mm thickness in the joint, so the area resisting tension is the same 10 mm × width. Usually butt welds fail in the base material if fully penetrated.

On the exam, if a problem involves a weld, sketch the weld shape and mark the throat. Remember: **shear stress = load / (weld throat area)**. And check units, especially if mixing metric and imperial (e.g. mm² vs in²). A common mistake is to use $F/(aL)$ instead of $F/(aL/\sqrt{2})$ – watch out for that factor.

K14.T09.S04 – Adhesive Bonding

- **Core idea:** Adhesive bonding uses a cured polymer or epoxy to chemically join surfaces. Joint strength is governed by shear strength of adhesive, and adhesives are much weaker in peel or cleavage than in shear.
- **Key facts:** Adhesives create a load-bearing bond across the entire contact area. They are typically rated by shear strength (e.g. 5–30 MPa for common epoxies) and peel strength (much lower). Proper surface preparation is crucial.
- **Why it matters:** The FE exam may include questions on joining choices: e.g. "Why choose adhesive bonding vs mechanical fastening for a composite panel?" or simple calculations of shear stress in an overlap joint. Understanding adhesive behavior helps in material/process questions (not typical numeric problems, but conceptual).
- **Questions:** Possibly a true/false or short answer: e.g. "Adhesives are better in peel than in shear." (False; they're typically weaker in peel.) Or "Calculate overlap length needed for a certain shear load if adhesive shear strength is given."

Definition Passport – Adhesive Bonding.

Adhesive bonding is the technique of joining two parts by applying a chemical adhesive that cures and holds the surfaces together. In everyday terms, think of it as a very strong glue that transfers loads over an area.

- *Exam impact:* Appears in design/manufacturing questions when comparing joining methods. You may need it in material selection, bonding composite joints, or analyzing a uniformly loaded lap joint.
- *Pitfall:* Most students assume adhesive bonds are like rigid welds; in reality, adhesives have limited shear strength and are *especially* poor in tension normal to the bond (peel). Don't confuse adhesive bonding with mechanical interlocking.
- *Micro-check:* True or False – "An adhesive joint's strength depends only on the adhesive's tensile strength." (False: it depends on shear strength of the bond and the bonded surface area.)

Footnotes: Adhesive joints often distribute load evenly (reducing stress concentrations), but require the bonded surfaces to be clean and matched. On the exam, if given adhesive shear strength τ_{adh} and load F, compute shear stress as F/A_{bond} similar to the formula above, using the overlap area. Peel stress (peeling the bond apart) can be approximated by bending moment per unit width, but is rarely calculated on FE.

Variations: Common adhesives include epoxies, acrylics, and structural adhesives. Epoxies might have $\tau_{allow} \approx 10$–30 MPa. Bonding of dissimilar materials (e.g. metal to composite) is an advantage. Adhesives are also used for vibration damping. Do not use adhesives for heavy shear loads without mechanical backup.

Special notes: To enter an adhesive shear calculation in a calculator, use the same stress formula $\tau = F/A$. Ensure to use the **overlap area** (bonded area), not the material cross-section. No special calculator functions needed beyond basic arithmetic.

Explanation & Analysis: Adhesive joints behave differently than bolts or welds. Under shear load, the entire bond area takes the load: $\tau = F/A_{\text{bond}}$. For example, if a 50 mm × 20 mm overlap patch with adhesive is loaded with 5 kN, the bond area is $50 \times 20 = 1000$ mm², so $\tau = 5000/1000 = 5$ MPa. If the adhesive's shear strength is 10 MPa, it's safe. If the same load acted perpendicular (trying to peel it off), the effective area is much smaller (like a line or edge), so the peel stress would be huge – adhesives are not good in that mode.

In summary, adhesives shine in shear-loaded, uniform joints (no holes to weaken structure), but not in peel. Always compare $\tau = F/A$ to adhesive spec. If the exam gives keywords like *"adhesive shear strength"*, check the exam handbook in the materials section (if listed) or use common sense values. Remember: if an adhesive bond must carry a high load, either increase overlap area or choose a stronger adhesive.

Topic 10 - Manufacturability

Manufacturability is about how easily and economically a designed part can be made. On exam day, questions on this topic often involve **fits and tolerances** (e.g. finding the clearance or interference between a shaft and hole) or choosing realistic tolerances and finishes. You might see a fit code like **H7/s6** and be asked to compute clearances. In this chapter we cover tolerances and fits, basis systems, geometric tolerances, and basic DFM considerations.

K14.T10.S01 – Tolerances and Fits

- **Tolerance:** Allowable variation in a part's dimension (difference between maximum and minimum size). Example: an IT7 tolerance on a 34 mm hole is about ±0.010 mm. *(Tighter tolerance = higher cost.)*
- **Fundamental deviation (δ_F):** Offset of the tolerance zone from the nominal size that is closest to zero. Its sign tells whether a fit will have clearance or interference.
- **IT grade:** A number (IT6, IT7, etc.) grouping tolerances by precision. A larger IT number means a looser tolerance.
- **Fit types:** *Clearance fit* (shaft always smaller than hole), *transition fit* (may just touch or slightly interfere), *interference fit* (shaft larger than hole).
- **Notation:** Fit codes like *H7/s6* use uppercase for the hole and lowercase for the shaft; numbers are the IT classes. For example, **34H7/s6** means a 34 mm basic size, hole with IT7, shaft with IT6.

Equation Passport: *Shaft Limits – Transition/Interference Fit*

$$d_{\min} = d + \delta_F, \qquad d_{\max} = d_{\min} + \Delta d$$

- *Variables:* d = basic shaft diameter; δ_F = fundamental deviation of the shaft; Δd = total tolerance of the shaft (from IT class).

- *Scope:* For fit classes k, p, s, u, n (interference or transition fits). Values are in **mm**.

- *Limit test:* If $\delta_F = 0$, then $d_{min} = d$ (shaft just meets nominal size).

- *Common traps:* Mixing up H/h or D/d; using the wrong sign for δ_F; forgetting units (handbook is metric).

- **Exam Handbook Cues:** Search for *limits and fits*, *fundamental deviation*, *clearance fit*, *H7/s6*. These keywords locate the FE Handbook tables.
- **Footnotes:** (1) All values here are in metric (mm). (2) Fundamental deviation is defined as the deviation closest to the basic size.
- **Variations:** For clearance-fit letters (d, g, h, c, f), the shaft limits would be $d_{max} = d + \delta_u$ and $d_{min} = d + \delta_l$. A hole-basis clearance example is *H7/h6* (hole lower dev=0). Typical precision tolerances are on the order of 0.001–0.010 mm.
- **Explanation:** Identify the basic size and fit code from the problem. Look up δ_F and Δd for the shaft class in the handbook. Compute $d_{min} = d + \delta_F$ and $d_{max} = d_{min} + \Delta d$. Compare to the hole: if $d_{max} > D_{min}$ it is interference (amount = $d_{max} - D_{min}$); if $d_{max} < D_{min}$ it is clearance ($D_{min} - d_{max}$).

K14.T10.S02 – Hole Basis vs Shaft Basis Systems

- **Hole-basis fit:** Hole is held at the nominal (basic) size. An uppercase "H" means the hole's lower deviation is zero. For example, *H7/h6* means a hole-basis fit (hole fixed, shaft clearance).
- **Shaft-basis fit:** Shaft is held at the nominal size. A lowercase "h" means the shaft's upper deviation is zero. E.g. *h6/H7* is the shaft-basis counterpart (shaft fixed).
- **Standard deviations:** The exam handbook (ASME B4.2) provides tables of upper and lower deviations for each letter (d, f, g, h, k, n, p, s, u, etc.) by size range. You will use these tables to get δ_u and δ_l for each tolerance letter.
- **Notation cue:** In a fit code, the first (capital) letter is the hole, the second (lowercase) is the shaft. So *H7/s6* is hole-basis, while *h7/S6* would be shaft-basis (H vs h swapped).

Definition Passport:

Basis Fit System – Tells which feature is kept at nominal size. "H" (uppercase) = hole fixed at basic size; "h" (lowercase) = shaft fixed.

- *Exam use:* Needed when interpreting fit codes to know which deviations are zero.

- *Pitfall:* Confusing "H" vs "h" (they have opposite meanings).

- *Quick check:* True/False: "In H7/s6, the hole is held at nominal." (True.)

- **Exam Handbook Cues:** Search *hole basis*, *shaft basis*, *fundamental deviation H*, *fundamental deviation h*.
- **Footnotes:** (1) Hole-basis (H) is the usual metric approach. (2) Both systems use the same mm tables; e.g. 'h' means shaft upper deviation = 0.
- **Explanation:** Determine the basis by looking at H or h. Then use the tables accordingly. For *H7/h6*, hole lower deviation = 0, shaft upper deviation = 0. Compute clearances or interferences the same way as before (compare D_{min} and d_{max}).

K14.T10.S03 – Geometric Tolerances (GD&T Basics)

- **Geometric tolerance:** A control on allowable variation in a feature's shape or orientation (flatness, concentricity, position, etc.) beyond just its size. This ensures parts have the correct form and fit.
- **RFS (default):** *Regardless of Feature Size* – no modifier (default condition).
- **MMC/LMC:** *Max/Least Material Condition* – modifiers indicating most or least material state. For example, a hole at MMC is its maximum possible size (must still meet positional tolerance).

- **Feature control frame:** The GD&T callout box on a drawing containing the symbol (⌀, ⌖, etc.), tolerance value, and any datums.

Definition Passport:

- *Geometric Tolerance* – A specification on a drawing that limits form/orientation/location error.

- *Exam use:* You may interpret GD&T symbols or compute virtual conditions.

- *Pitfall:* Don't mix up GD&T (form/orientation) with size tolerances.

- **Exam Handbook Cues:** Search *GD&T*, *flatness*, *position*, *MMC*, *feature control frame*.
- **Footnotes:** (1) If no modifier is given, assume RFS. (2) Units for GD&T tolerances are in mm (or degrees for angular specs).
- **Variations:** There are many symbols. E.g. a callout "⌖0.02 @ MMC" means a positional tolerance of 0.02 mm when the feature is at its maximum material size. The virtual condition (VC) of a feature is its MMC size plus the tolerance. Typical GD&T values might be a few hundredths of a mm.
- **Explanation:** GD&T ensures features meet design form. For instance, a flatness of 0.01 mm means all surface points lie between two planes 0.01 mm apart. If MMC is shown, compute VC: hole's VC = (hole max diameter) + tolerance. On the FE exam, identify each symbol and apply any modifiers (e.g. add tolerance at MMC).

K14.T10.S04 – Design for Manufacturability

- **Tolerances:** Don't make them tighter than needed. Overly tight tolerances greatly increase cost and scrap. If a dimension isn't function-critical, specify a larger tolerance.
- **Surface finish:** Specify achievable Ra values. Ra is in µm (µin). For example, Ra 3.2 µm (125 µin) is typical machined finish; only use Ra 0.8 µm (32 µin) on very critical surfaces.
- **Process & sizes:** Favor standard sizes and simpler processes. E.g. use a sliding fit (e.g. H7/h6) instead of a press fit (H7/s6) if possible, or choose a round standard diameter (25.00 mm instead of 25.37 mm).

Definition Passport: *Design for Manufacturability* – The practice of choosing tolerances, finishes, and sizes that simplify production.
- *Exam use:* If a problem hints at high cost or difficulty, the answer is usually to relax specs (loosen a fit or tolerance).
- *Pitfall:* Assuming "tighter is always better." In design, looser tolerances that still meet function are preferable.

- **Exam Handbook Cues:** Search *manufacturability*, *tolerances*, *surface finish*, *cost*.
- **Footnotes:** (1) Finish conversion: Ra 1.6 µm ≈ 63 µin. (2) Typical machining tolerance: ±0.02–0.05 mm; precision grinding: ±0.002–0.01 mm.
- **Variations:** Example: changing from H7/s6 (interference) to H7/h6 (clearance) eases assembly. Specify coarser Ra where detail isn't needed.
- **Explanation:** Always ask "Is this spec really necessary?" On exam problems, if hints of cost or difficulty appear, recommend making tolerances coarser or using standard sizes. For instance, you might answer "increase clearance" or "relax this tolerance" to reduce manufacturing effort.

Topic 11 - Quality and Reliability

Not affiliated with or endorsed by NCEES. Quality and reliability are critical to ensuring that mechanical designs meet specifications and perform as intended over time. On the FE Mechanical exam, questions in this topic ask you to monitor process quality (with charts and capability indices) and predict system performance (with reliability formulas). In practice these tools help you answer: "Is my manufacturing process under control and within tolerances?" and "How likely is a machine or system to work without failing?" Being fluent in these concepts and how to find them in the exam handbook will save time during the test.

K14.T11.S01 – Statistical Quality Control: Control Charts

- **Purpose:** Track a process using sample statistics to detect when it goes out of control. Typically an X-bar (mean) chart monitors the process average, and an R (range) chart monitors variability.
- **Key idea:** Plot each sample's mean ($\bar{X}$) and range (R) on control charts. The center line (CL) is the overall mean or average range. Upper and lower control limits (UCL, LCL) are set at about ±3 standard-error (based on R) around the center. Points outside these limits, or unusual runs of points, signal a possible problem.
- **Typical use:** During exam problems on quality, you may be given sample means or ranges and asked to compute control limits or identify an out-of-control point. These charts assume normally-distributed output and independent samples.
- **Examples:** If several batches of parts are measured for a dimension, you might compute the average and range of each batch and plot them to see if the process drifts or suddenly jumps out of spec.

Exam Handbook Search Cues (Not affiliated with or endorsed by NCEES): "control chart," "X-bar," "R chart," "A_2," "D_3," "D_4," "out-of-control."

Footnotes:

- Symbols: $\bar{X}$ = sample mean, $\bar{R}$ = average of sample ranges. A_2, D_3, D_4 are tabulated constants (depend on sample size n). The units of $\bar{X}$ and $\bar{R}$ match the measured characteristic (e.g. mm or in). The indexes n, k (sample size and number of samples) are assumed fixed.
- Scope: Charts assume a stable underlying process with known distribution shape (usually normal). They do *not* check specification limits directly – only statistical variation.
- Hidden assumption: Control limits use ±3σ rules. In practice we approximate σ via $\bar{R}$ (see formulas).

Variations & Typical Values:

- A small sample size gives wide control limits: e.g. $A_2 \approx 1.88$ when $n = 2$, decreasing to $A_2 \approx 0.577$ when $n = 5$. As n increases, D_3 stays 0 (LCL = 0) for $n < 6$, then grows. Typical values: for $n = 5$, $D_3 = 0$, $D_4 \approx 2.11$. In some cases you might use an σ-chart (with known σ) instead of an R-chart if the standard deviation is known.
- Related charts: A *σ-chart* uses sample standard deviations and constants A_3, B_3, B_4. A *P-chart* or *U-chart* handles proportions/counts. For FE Mechanical, focus on X-bar and R-charts.

Special Notes (Calculator): Simply compute means and ranges normally. There are no built-in functions for control charts; use basic arithmetic.

Explanation & Analysis:
A control chart helps you *visualize* if a process is statistically "in control." To set it up, you first compute the grand average of all sample means, $\bar{X}$ (CL_X), and the average range $\bar{R}$ (CL_R). The exam handbook gives the formulas (in the exam's reference PDF) for the control limits. In effect:

- **X-bar chart:** The center line is $CL_X = \bar{X}$. The limits are $UCL_X = \bar{X} + A_2\,\bar{R}, \quad LCL_X = \bar{X} - A_2\,\bar{R}.$

  This means we set upper and lower control limits roughly 3 sample-sigma above and below the mean.
- **R chart:** The center line is $CL_R = \bar{R}$. The limits are $UCL_R = D_4\,\bar{R}, \quad LCL_R = D_3\,\bar{R}.$

  Here D_4 and D_3 effectively set ±3σ on the range scale; for small n, LCL_R is often zero.

Each symbol represents a statistical quantity: $\bar{X}$ is the mean of means (in the same units as the measurement, e.g. mm), $\bar{R}$ is the mean range of each subgroup, A_2, D_3, D_4 are dimensionless constants that depend on subgroup size n. For example, with $n = 5$, $A_2 \approx 0.577$ and $D_3 = 0, D_4 \approx 2.114$.

Equation Passport: X-bar Chart Control Limits – Sets the center line and 3-sigma limits for sample means in a control chart.

$$CL_X = \bar{X}, \quad UCL_X = \bar{X} + A_2\,\bar{R}, \quad LCL_X = \bar{X} - A_2\,\bar{R}.$$

- **Variables:** $\bar{X}$ = grand mean of all sample means; $\bar{R}$ = grand mean of all sample ranges; A_2 = control chart constant (unitless, from table).

- **Assumptions:** Process data are normally distributed and independent; subgroup size n is fixed. The chart is based on 3-sigma limits (±3σ).

- **Limit tests:** As n increases, A_2 decreases (tighter limits). If process variation is tiny ($\bar{R} \to 0$), UCL/LCL both approach $\bar{X}$.

- **Use vs sibling:** Use X-bar chart (above) when you track the process average. Don't confuse with an R chart (below), which tracks variability.

- **Common pitfalls:** Using the wrong A_2 value for your n; mixing up $\bar{X}$ (mean) and $\bar{R}$ (range); forgetting that LCL cannot go below zero for R charts.

Equation Passport: R Chart Control Limits – Sets control limits for the sample range R.

$$CL_R = \bar{R}, \quad UCL_R = D_4\,\bar{R}, \quad LCL_R = D_3\,\bar{R}.$$

- **Variables:** $\bar{R}$ = average of subgroup ranges; D_3, D_4 = constants (from table). For $n < 6$, often $D_3 = 0$ (so $LCL = 0$).

- **Assumptions:** Same as X-bar chart: consistent subgroup size, normal data, etc. Range assumes small sample size.

- **Limit tests:** As n grows, $D_4 \to 1$ and $UCL_R \to \bar{R}$ (less variation). If one sample has large spread, it could exceed UCL_R.

- **Use vs sibling:** Use R-chart (above) to check process spread. If the range is out of control, the X-chart limits from $\bar{R}$ may no longer be valid.

- **Common pitfalls:** Forgetting that LCL may be zero; applying R-chart logic to non-range data.

After plotting, apply the **Western Electric rules** for out-of-control tests. For example, *any* single point outside the control limits signals a problem. Also look for patterns (e.g. 2 of 3 in Zone A, 4 of 5 in Zone B, or 8 consecutive on one side). In practice, if a point falls beyond the UCL or below the LCL, you should investigate that sample for special causes. Similarly, runs or trends (successive points on one side) indicate a potential drift.

In exam problems, you'll often be given subgroup data and asked to compute $\bar{X}$, $\bar{R}$, and then these limits. Watch for units (keep consistent), and be careful using the correct chart constants for your sample size. Remember that control charts monitor a process over time; they do *not* directly use specification limits. Instead, they catch changes in the process mean or variability.

K14.T11.S02 – Process Capability Indices (C_p, C_{pk})

- **Purpose:** Quantify how well a process can hold engineering tolerances. C_p reflects the **potential** capability assuming the process is centered, while C_{pk} reflects the **actual** capability by accounting for any shift in the process mean.
- **Key idea:** Compare the natural process spread (usually taken as 6σ) to the total tolerance width (USL–LSL). If the process variation is much smaller than the tolerance, C_p will be high (good). If not, the process may produce out-of-spec parts. C_{pk} further halves the difference between the process mean and each spec limit.
- **Typical use:** In exam questions you may compute C_p and C_{pk} from given σ and spec limits. Then conclude if the process *can* meet specs (often $C_p > 1$ is the rule of thumb).
- **Interpretation:** $C_p < 1$ means the process spread exceeds tolerance (bad). $C_{pk} < 1$ means even if C_p is ok, the mean is off-center. Ideally $C_{pk} \geq 1$.

Exam Handbook Search Cues (Not affiliated with or endorsed by NCEES): "process capability," "C_p, C_{pk}," "USL," "LSL," "tolerance," "σ."

Footnotes:

- Units: C_p and C_{pk} are dimensionless ratios. USL (upper spec limit) and LSL (lower spec limit) must be in the same units as μ, σ.
- Symbol convention: μ = process mean; σ = process standard deviation (long-term).
- Scope: These assume a *normal* process distribution (so 6σ covers virtually all output). They do **not** work if the distribution is grossly non-normal.
- Hidden assumption: We often assume "6σ" = $\pm 3\sigma$ covers all variation. In reality, normal 3σ is ~99.7%, but smaller percentages if distribution changes.

Variations & Typical Values:

- If the process is perfectly centered (μ at midpoint), $C_{pk} = C_p$. In that case, "potential capability" = "actual capability." If μ shifts, C_{pk} drops.
- If there is only one spec limit (e.g. only LSL or only USL), you'd use the formula for one side.
- Typical example: If USL–LSL = 0.020 and σ = 0.001, then $C_p = (0.020)/(6 \times 0.001) = 3.33$, a very capable process. But if the mean is 0.005 above center, C_{pk} would be $\min\big((USL - \mu)/3\sigma, (\mu - LSL)/3\sigma\big)$.
- Large processes often target $C_p \approx 1.33$ or higher for Six-Sigma levels.

Special Notes (Calculator): Use the calculator's memory to store spec limits, mean, or σ if needed; there's no built-in "Cp" function. If you have to compute σ from data first (e.g. from ranges or variance), be careful with unit conversions.

Explanation & Analysis:
Process capability compares tolerances (design limits) to process variation. The basic formulas are (as given in the exam's handbook):

Equation Passport: Potential Capability C_p – ratio of tolerance width to process spread (centered process).

$$C_p = \frac{USL - LSL}{6\sigma}$$

- **Name & purpose:** C_p measures how wide the tolerance is relative to a centered process's ±3σ spread. A larger C_p means plenty of tolerance.

- **Variables:** USL = upper specification limit; LSL = lower spec limit; σ = process standard deviation. (All in same units.)

- **Assumptions:** The process is well-centered at mid-tolerance; normally distributed output; 6σ covers the range of nearly all parts.

- **Limit tests:** If $\sigma \to 0$, $C_p \to \infty$ (trivially good process). If $\sigma \to \frac{USL-LSL}{6}$, then $C_p = 1$.

- **Use vs sibling:** Use C_p when you only care about total spread; if the process isn't centered, switch to C_{pk}.

- **Common pitfalls:** Forgetting factor 6 (some mistakenly use ±3σ = total 6σ). Mixing up USL–LSL (wide vs narrow tolerance). Not using the long-term σ (e.g. using sample σ blindly).

If the process mean μ is not centered, the actual attainable capability is captured by C_{pk}. It is defined as the minimum of how far the mean is from each spec in terms of 3σ. Formally:

Equation Passport: Actual Capability C_{pk} – capability accounting for mean offset.

$$C_{pk} = \min\left(\frac{USL - \mu}{3\sigma}, \frac{\mu - LSL}{3\sigma}\right).$$

- **Name & purpose:** C_{pk} finds the worst-case side of the process relative to its specs. It answers "how far is the mean from the nearest spec, in σ-units?" A low C_{pk} means some output will miss tolerance.

- **Variables:** μ = process mean; other symbols as above.

- **Assumptions:** Same normality and fixed-σ assumptions as C_p. Process mean is fixed (no drifting).

- **Limit tests:** If $\mu = (USL + LSL)/2$ (perfectly centered), then $(USL - \mu) = (\mu - LSL)$ and $C_{pk} = C_p$. If μ moves towards one limit, that side's term shrinks.

- **Use vs sibling:** Use C_{pk} instead of C_p when you have a mean shift to consider. For an ideal centered process, C_{pk} simply equals C_p.

- **Common pitfalls:** Incorrectly taking max instead of min; forgetting to take the smaller of the two terms. Mixing up 3σ vs 6σ.

In practical terms, for the FE exam you might compute these indices and then judge capability. A rule of thumb: if $C_{pk} < 1$, the process *cannot* reliably stay within tolerances (exam often expects you to say "not capable"). Always double-check units and that you plugged the correct numbers into the formula.

K14.T11.S03 – Reliability Basics (Definition, Failure Rate, MTBF)

- **Purpose:** Predict how long a part or system will last without failing. Reliability quantifies the chance of "survival" over time, often assuming random (statistical) failures. Key concepts include the reliability function $R(t)$, the failure (or hazard) rate λ, and the mean time between failures (MTBF or MTTF).
- **Key idea:** Reliability $R(t)$ is defined as the probability that an item works (no failures) up to time t. If failures occur randomly at a constant rate λ, the exponential reliability model applies: $R(t) = e^{-\lambda t}$. The parameter λ has units of "failures per time" (e.g. 0.001 per hour). MTBF is simply the reciprocal of λ (for constant-rate, nonrepairable items).
- **Typical use:** On the exam, you might be given a failure rate or MTBF and asked for reliability over a period, or vice versa. For example: "Given $\lambda = 0.0002$ per hour, what is the probability no failure occurs in 500 hours?" Use $R = e^{-\lambda t}$.
- **Examples:** If light bulbs fail at a constant rate, you could compute the probability a bulb lasts a year. In maintenance scheduling, knowing MTBF helps plan service intervals.

Exam Handbook Search Cues (Not affiliated with or endorsed by NCEES): "reliability," "failure rate," "hazard function," "exponential distribution," "MTBF," "mean time between failures."

Footnotes:

- Units: $R(t)$ is dimensionless (a probability, usually between 0 and 1). λ has units of 1/time (e.g. per hour). MTBF has time units (hours, cycles, etc.).
- Symbol note: Some authors use MTBF (repairable systems) vs MTTF (nonrepairable). Here treat them the same (expected life).
- Scope: Exponential model (constant λ) is memoryless: the chance of failure in the next moment does not depend on age. This is common for electronics and some mechanical parts under random failure.
- Assumption caveat: Not all failure distributions are exponential. If exam gives a different formula (Weibull, etc.), use that context. FE will usually stick to constant-failure-rate as a basic case.

Variations & Typical Values:
- If λ increases, reliability decays faster. For example, $\lambda = 0.001$/hr (one failure per 1000 hrs on average) vs $\lambda = 0.01$/hr.
- When λ is small, $R(t) \approx 1 - \lambda t$ for small t. If MTBF = 1000 hr, then $\lambda = 0.001$/hr.
- Real systems may have an initial "burn-in" or wear-out (non-constant λ), but FE exam basic problems will not introduce that complexity.

Special Notes (Calculator): Use the exponential and logarithm functions as needed. For $R = e^{-\lambda t}$, on calculators compute $\exp(-\lambda t)$. If solving for λ given MTBF, recall $\lambda = 1/\text{MTBF}$.

Explanation & Analysis:
At its core, **reliability** $R(t)$ answers: *What is the probability that a component does not fail before time t?* By definition, $R(0) = 1$ (certainly no failure at time zero) and $R(t)$ decreases with t. The simplest model assumes a constant failure rate λ (failures occur randomly in time). In that case, the reliability function is exponential.

Definition Passport: Reliability $R(t)$ – Probability that an item functions without failure up to time t. (Symbol: $R(t)$.)

- Plain definition: *"Reliability is the probability the part survives to time t without failing."*

- Exam context: Used whenever a question involves part lifetimes or failure probabilities (e.g. calculating % surviving after some time, system uptime, etc.).

- Pitfall: Students sometimes confuse reliability with unreliability $F(t)$ (failure probability). Note that $R(t) + F(t) = 1$. Also watch units: t must match the time unit used for λ.

- Micro-check: *True/False:* $R(0) = 1$. (Answer: True – initially, survival probability is 100%.)

When λ is constant, the **exponential reliability formula** applies. Many FE problems implicitly assume this. The formula is:

Equation Passport: Exponential Reliability (constant λ) – gives probability of no failure by time t.

$$R(t) = e^{-\lambda t}.$$

- **Name & purpose:** Calculates reliability for components with constant failure rate λ. Use this when "memoryless" behavior is implied.

- **Variables:** λ = (constant) failure rate (e.g. failures per hour), t = time of interest. $R(t)$ is dimensionless (a probability).

- **Assumptions:** Hazards constant; no aging effect; failures are random in time. Implies the underlying life distribution is exponential.

- **Limit tests:** As $t \to 0$, $R \to 1$ (part is almost certain to survive a tiny interval). As $t \to \infty$, $R \to 0$. If $\lambda \to 0$, $R(t) \to 1$ (almost no chance of failure).

- **Use vs sibling:** Use this formula instead of other life models (e.g. Weibull) when the exam states or implies a constant λ. If only MTBF is given, you can derive λ as $1/\text{MTBF}$.

- **Common traps:** Forgetting the minus sign in the exponent (should be $-\lambda t$). Mixing up units of time (make sure λt is unitless).

A related concept is **Mean Time Between Failures (MTBF)**, often simply the inverse of λ in the exponential model. It is the expected lifetime of the item.

Equation Passport: Mean Time Between Failures (MTBF) – expected time between failures (exponential case).

$$\text{MTBF} = \frac{1}{\lambda}.$$

- **Name & purpose:** MTBF (or MTTF) is the average operational time before a failure occurs. It helps design maintenance intervals.

- **Variables:** λ as above. MTBF has time units (e.g. hours).

- **Assumptions:** Only holds exactly when failures are exponential (constant λ). For non-exponential, MTBF is defined differently (not on FE exam).

- **Limit tests:** As $\lambda \to 0$, MTBF $\to \infty$. As $\lambda \to \infty$, MTBF $\to$ 0.

- **Use vs sibling:** If the exam gives a numeric MTBF but not λ, compute $\lambda = 1/\text{MTBF}$ and then find $R(t)$. Often MTBF is given directly.

- **Common traps:** Confusing MTBF (for a repairable system) with MTTF (for a one-time failure). On FE, treat them similarly. Also, ensure consistent time units (e.g. λ in per-hour vs MTBF in hours).

In summary, for reliability basics, remember: *Reliability decays exponentially with time if failure rate is constant*. Use $R = e^{-\lambda t}$ and $MTBF = 1/\lambda$. Keep track of units and definitions.

K14.T11.S04 – System Reliability (Series vs. Parallel)

- **Purpose:** Compute the reliability of a system made of multiple components. In many mechanical systems, components are arranged in series (all must work) or in parallel (backup paths), or combinations.
- **Key idea:** For **series systems** (like bulbs in series on a string), the system fails if *any* component fails. If components fail independently, the system reliability is the *product* of individual reliabilities. For **parallel systems** (like redundant pumps), the system works if *at least one* component works; the formula is 1 minus the probability that all fail.
- **Typical use:** The exam may ask: "Given component reliabilities, find system reliability." Often simple cases are series or all-parallel. If redundancies are in place (parallel branches), system reliability is higher than any single component's.
- **Examples:** A system with 3 identical pumps in parallel with reliability 0.9 each has $R_{\text{system}} = 1 - (1 - 0.9)^3 = 0.999$. In series (like three gears in line), $R_{\text{system}} = 0.9^3 = 0.729$.

Exam Handbook Search Cues (Not affiliated with or endorsed by NCEES): "series reliability," "parallel reliability," "system reliability," "redundancy," "availability."

Footnotes:

- Units: All R values are probabilities (dimensionless between 0 and 1). Reliability of each component R_i must be given or computed (for identical parts, you might use the same formula for each).
- Assumptions: Component failures are independent. Instantaneous switching or perfect redundancy in parallels (no time lost). All components are required to work (series) or any one is enough (parallel).
- Scope: Only simple series and parallel formulas are in scope; complex network reductions or partial redundancy are beyond FE depth. Also, repair and maintenance factors are not included here (that would be "availability" or more advanced).

Variations & Typical Values:

- Mixed systems: More complex arrangements (series-parallel combos) often require combining these rules stepwise. For example, if two series branches are in parallel, compute each branch reliability then combine in parallel.
- Typical reliability values for high-quality components might be 0.9–0.99 for a given time period. For example, a single bearing might have $R = 0.98$ over 1000 hours; two in parallel would then yield $R = 1 - (1 - 0.98)^2 = 0.9996$.
- Adding redundancy: Each extra parallel component dramatically increases R. Conversely, adding series elements multiplies (and thus decreases) R.

Special Notes (Calculator): Simply multiply probabilities; no special function needed. Be careful with the expression for parallel (often easiest to compute the complement of all failing).

Explanation & Analysis:
System reliability combines component reliabilities according to how the components are arranged:

Equation Passport: Series System Reliability – All components must work.

$$R_{\text{system}} = \prod_{i=1}^{n} R_i$$

- **Name & purpose:** For components 1through $n$in series, the system reliability is the product of each component's reliability R_i. If any component fails, the whole system fails.
- **Variables:** R_i =reliability of component i. Typically each $R_i$is given or previously calculated.
- **Assumptions:** Failures are independent; system fails on any single failure. All $R_i$refer to the same mission time t.
- **Limit tests:** If any $R_i = 0$, then $R_{\text{system}} = 0$. If all $R_i = 1$, then $R_{\text{system}} = 1$. Adding more series components (increasing n) always decreases R_{system}.
- **Use vs sibling:** Use this formula instead of parallel when components are in series (e.g. train of gears or lights). Don't use it for parallel cases.
- **Common pitfalls:** Accidentally adding reliabilities instead of multiplying. Neglecting that all probabilities

are <1, so the product is <each individual. Forgetting to use the same time basis for each R_i.

Equation Passport: Parallel System Reliability – At least one component works.

$$R_{\text{system}} = 1 - \prod_{i=1}^{n}(1 - R_i)$$

- **Name & purpose:** For components in full parallel (any one can support the system), the system reliability is one minus the probability all components fail.
- **Variables:** Same $R_i$as above. The term $(1-R_i)$is the failure probability of component i.
- **Assumptions:** Independent failures; at least one component must succeed for system success. Instantaneous perfect switchover.
- **Limit tests:** If any single $R_i = 1$, then $R_{\text{system}} = 1$(perfect component makes system fail-proof). If all $R_i = 0$, $R_{\text{system}} = 0$. More parallel components (larger n) always increases R_{system}.
- **Use vs sibling:** Use this form for parallel (redundant) configurations. Do not sum $R_i$directly.
- **Common pitfalls:** A frequent mistake is summing probabilities instead of using the "all fail" trick. Remember that

$$1 - (1 - R_1)(1 - R_2) \neq R_1 + R_2.$$

Also check that each $R_i$is a probability (always ≤ 1).

These formulas come directly from the definition of probability for independent events. For example, two components in series with reliabilities 0.9 and 0.8 give $R = 0.9 \times 0.8 = 0.72$. The same two in parallel give $R = 1 - (0.1 \times 0.2) = 0.98$. The exam may ask you to compare series vs parallel setups or add redundancy. In all cases, clearly identify which components are in series or parallel, then apply the appropriate formula.

Remember that redundancy (parallel elements) is a common way to boost reliability. For instance, *adding a second identical component in parallel* with reliability R changes the system reliability to $1 - (1 - R)^2$. This can be a good spot to use a calculator for exponentials or powers.

Common Exam Tip: When solving reliability problems, always double-check if the question expects a probability or a percent, and keep track of the time period. For example, if given MTBF, convert to λ first, then compute $R(t)$. And if combining components, write down each R_i before applying the formula to avoid mixing up units or forgetting the minus signs in parallel formulas.

Topic 12 - Components

Mechanical Design & Analysis – *Components* covers the core devices that make machines work: pumps, motors, valves, cylinders, linkages, couplings, and related parts. On FE exam day, you will encounter schematics or descriptions of such components, and often must identify them by symbol or compute a quantity (force, speed, torque) they produce. For example, you might be given a hydraulic circuit and asked for the piston force, or a motor–gear system and asked for output speed. **Knowing the official keywords and symbols in the exam handbook for each component** is crucial. In this chapter we cover each item: what it does, its governing formula (if any), typical behavior, and how to spot it on the FE exam. Think of this as your "passport" to mechanical components: a quick reference to identify each device, recall the key equation, and avoid common pitfalls.

K14.T12.S01 – Hydraulic Power Components

Principle Introduction:

- Hydraulic systems use incompressible fluid (usually oil) to transmit power. The *pump* is the source of flow and pressure (driven by an electric motor). It sends oil through *control valves* and pipes to *actuators* (hydraulic cylinders or motors). These components are drawn with standard ANSI symbols in the exam handbook. Recognize a pump by its circle with an arrow, a cylinder by a piston symbol, and valves by the number of ports/arrows.

- A **hydraulic pump** converts mechanical torque into fluid energy. It creates a flow Q at some pressure P. This pressure does work on actuators. **Hydraulic motors** do the reverse (fluid in → rotation out). A *cylinder* (linear actuator) pushes a piston to produce a force. The basic relation is

$$F = P\,A$$

where A is the piston area. In practice, a **single-acting cylinder** (one port) applies force in one direction; a **double-acting cylinder** (two ports) can push and pull (two arrows on symbol).

- **Valves** control the flow and pressure. Directional valves route fluid (e.g. 2-way, 3-way, 4-way valves – see examiner's symbol list). A *relief valve* or *pressure regulator* limits system pressure (like a spring-loaded pop-off valve). A *check (nonreturn) valve* allows flow one way only. For example, if the exam gives you a relief-valve symbol and a set pressure, that valve will open to bypass fluid when P exceeds its setting. Always trace the path: a pump pushes oil → valve → cylinder.

- In exam problems, sketch a simple free-body view of the circuit: identify pressure sources and where fluid does work. **Key idea:** pressure (from pump) acts over piston area to give force, or fluid flow through a motor produces torque.

Exam Handbook Search Cues (Not affiliated with or endorsed by NCEES): *hydraulic pump*, *hydraulic cylinder*, *pressure relief valve*, *flow control valve*, *hydraulic motor*. Use these to look up symbols or formulas.

Footnotes:

- **Units and notation:** Pressure P is often given in psi or bar (pressure units); area in in² or m². Recall 1 psi·in² = 1 lbf. Be careful with *lbf vs. lbm* if US units are mixed. If using SI, convert psi to Pa and in² to m². Always include the unit (e.g. 3000 psi × 2 in² = 6000 lbf).

- **Symbols:** In exam sketches, note arrows: one arrow on a pump symbol means fixed displacement (one-way flow), two arrows mean variable or bidirectional pump. A double-acting cylinder has two arrows (one on each side of the piston). A double-acting symbol yields force in both extend and retract strokes.

- **Pressure type:** Generally, pressures on the exam are gauge (above atmospheric) unless stated. So you can usually plug values directly into $F = PA$ without adding 14.7 psi.

- **Pump capacity:** When needed, pump flow Q (e.g. in L/min or GPM) and cylinder area A give piston velocity by $v = Q/A$. (Convert units consistently: e.g. mm² to m²).

Variations & Related Forms:

- The core formula $F = P\,A$ is equivalent to $P = F/A$. If asked for area, use $A = F/P$. For **hydraulic cylinders**, a typical diameter might be a few centimeters (yielding areas of order 10^{-4}–10^{-3} m²).

- Pump *power* (useful but rarely needed): hydraulic power $P_{hyd} = Q\,\Delta p$ (flow × pressure drop). Not needed for basic cylinder force problems.

- In multiple-cylinder systems, each cylinder gets the same pressure (series circuit), so they each produce $F = PA$. If cylinders share flow (parallel circuits), flow divides. Keep track if more than one port is open.

- **Pressure relief valve:** Opens at its set pressure P_{set}. If system pressure tries to exceed P_{set}, the valve diverts flow back to the tank. (Not an equation, but a common device in problems.)

Special Notes:

- On the approved FE calculators, simply type the formula. No special function keys are needed for $F = PA$. Just be consistent with units (e.g. if P in Pa and A in m², F comes out in newtons).

- **Calculator tip:** some calculators can compute in mixed units if you use the unit-math feature; otherwise convert first. Always check after entering: e.g. $P = 3000$ psi, $A = 5\ \text{in}^2 \rightarrow F = 3000 \times 5 = 15000$ lbf.

Explanation & Analysis:

When you see a hydraulic schematic, identify the pump (circle with arrow) and actuator (cylinder or motor symbol). Suppose a problem gives a pump pressure and cylinder diameter and asks for force. You'd (1) compute the piston area $A = \pi d^2/4$, (2) multiply by pressure: $F = PA$. For example, a 4 in diameter cylinder at 1000 psi yields $A = 12.57\ \text{in}^2$, so $F = 12.57 \times 1000 = 1.257 \times 10^4$ lbf. Always label units: $1000\ \text{psi} \times 12.57\ \text{in}^2 = 12570$ lbf.

If a valve is present, check if it changes the circuit. For instance, a flow-control valve restricts flow (reducing cylinder speed); a pressure-relief valve caps pressure. But for simple FE questions, focus on the primary path: pump → actuator → cylinder force.

Most mistakes come from unit mix-ups or misreading the symbol: e.g., plugging diameter instead of radius into area, or using psi with m². Also be aware that hydraulic **pressures** can be extremely high (hundreds to thousands of psi), so answer forces can be large.

- **Step-by-step:** Sketch FBD of piston; mark pressure on face; apply $F = PA$. If the fluid drives a motor instead of a cylinder, use torque = P \times motor's effective area (or simply use the gear/belt methods in Subtopic 4 after converting pressure to force on the gear teeth).
- **Units**: Check before and after. If pressure was in psi and area in in², result is lbf (skip g_c conversion). If you mix SI/US units, explicitly use g_c or convert all to one system.
- **Common pitfalls:** Forgetting to convert inches to feet in USCS (e.g. 1 in = 1/12 ft) when needed. Using gauge pressure (no extra 14.7 psi needed). Messing up a double-acting cylinder by only computing one side's force (each side acts independently).

Cylinder Force – computes the thrust from fluid pressure on a piston.

$$F = P\,A$$

- **Variables:** F = force (N or lbf), P = fluid pressure (Pa or psi), A = piston area (m² or in²).

- **Assumptions:** Incompressible, steady fluid; pressure is uniform on the piston face; piston seals perfectly. (No leak or fluid acceleration effects considered.)

- **Limit tests:** If $P \to 0$, then $F \to 0$; if $A \to 0$, $F \to 0$. (At zero pressure or zero area, no force.) As $P \to \infty$, $F \to \infty$ – unrealistic, since actual systems have reliefs.

- **Use vs. similar:** Use $F = PA$ for any fluid-actuated piston or cylinder. (For a hydraulic motor, use the same idea: torque $\tau = P \times A_r$, where A_r is the motor's reaction area.)

- **Common traps:** Mixing unit systems (e.g. psi×m²). Confusing diameter vs. radius when computing A. Neglecting that pressure may be given in gauge. Using lbf vs. lbm incorrectly; recall $1\ \text{lbf} = 1\ \text{lbm} \cdot 32.174\ \text{ft/s}^2$ if needed in force/mass conversions.

K14.T12.S02 – Basic Pneumatics

Principle Introduction:

- Pneumatic systems are like hydraulics but use compressed air or gas. Key components: **compressor** (pressurizes air), **air cylinder** (pneumatic actuator), and **pressure regulator** (controls cylinder pressure). Schematically, pneumatic symbols resemble hydraulic ones (see the arrow for "air" in the ANSI chart). Air cylinders exert force $F = PA$ just like hydraulic cylinders, but typical pressures are much lower (tens to ~150 psi for industrial air).

- A **compressor** draws in atmospheric air and delivers it at higher pressure into a tank or circuit. On exam schematics, a compressor may be drawn as a special pump symbol or simply labeled. Its job is to supply a steady pressure source (e.g. 100 psi). Downstream of the compressor is usually a pressure **regulator** or **filter/regulator** which sets a lower working pressure (and removes moisture).

- An **air cylinder** pushes a piston with compressed air. Despite air compressibility, treat force calculation exactly as $F = P\,A$ if pressure P is given. For example, a 50 psi regulator output and a 2 in² piston gives $F = 50 \times 2 = 100$ lbf. Unlike hydraulics, air expands – but for small motions or quasi-static problems, volume changes need not be explicitly handled on the FE.

- In circuits, **one-way check valves** and **flow control valves** also appear in pneumatics. For instance, a quick-exhaust valve might be shown (it vents air fast). On the exam, recognize the solenoid or regulator symbols: a pressure regulator is often a valve with a spring symbol on top. Functionally, it holds downstream pressure constant.

Exam Handbook Search Cues (Not affiliated with or endorsed by NCEES): *pneumatic cylinder*, *air compressor*, *pressure regulator*, *servomotor pneumatic*, *pneumatic valve symbol*.

Footnotes:

- **Pressure units:** Air pressure may be given in psi, bar, or kPa. 1 bar ≈14.5 psi, 100 kPa ≈ 14.5 psi. Use consistent units.

- **Compressibility:** Air is compressible, but many FE problems assume **isothermal** or **adiabatic** behavior only if explicitly in Thermo. For a quick force check, assume ideal gas only when volume changes matter (rare for elementary pneumatics questions).

- **Speed vs. Force:** Because air is compressible, pneumatic cylinders often run at high speed but produce relatively low force. Double-acting cylinders still use $F = PA$, but the force drops on retract stroke if one side is vented to exhaust at atmospheric pressure.

Variations & Related Forms:

- *Force formula:* $F = PA$ applies. If a cylinder pulls in one direction (single acting), use only the pressure side. For double-acting, you may need to account for opposing pressures on both sides of the piston.

- **Vacuum vs. pressure:** If a vacuum is involved (unlikely on FE), pressure difference is still $P_{atm} - P_{vac}$.

- **Typical values:** Industrial air compressors deliver ~90–120 psi. Cylinder areas ~0.005–0.02 m² (for small cylinders). Pressure regulators often adjustable from 0 to set value (like 0–60 psi or 0–5 bar ranges).

Special Notes:

- FE calculators: same as hydraulics. Simply input $F = P \times A$. If given pressure in psi and area in in², get lbf. No special keys beyond scientific notation if needed.

- Keep **air/water analogy** in mind: treat valves and cylinders identically to hydraulics in terms of P–A relationships. The handbook symbols may not explicitly say "air", but context (triangle arrow, reservoir) implies gas.

Explanation & Analysis:

Pneumatic devices on the exam behave like their hydraulic counterparts. If a question shows an air cylinder and gives line pressure (say 80 psi), compute force the same way. For example, a 3 in diameter cylinder at 80 psi: $A = \pi(3/2)^2 = 7.07\ \text{in}^2$, so $F = 80 \times 7.07 = 565.6$ lbf. Always confirm whether the problem means supply pressure or cylinder-side pressure (if regulator is in line, use the regulated pressure).

If a flow control valve is used, the question might be about speed (then use continuity $Q = Av$). For pressure regulators: when set to P_{set}, the output is locked at that pressure. A solenoid valve (often used in pneumatics) will have a coil symbol (the exam handbook shows a solenoid coil symbol). Energizing it shifts a valve spool. For FE purposes, just know that an "energized solenoid" means the valve has switched to its alternate state (usually drawn in the diagram).

- **Step-by-step:** Identify if air pressure is constant. Compute $F = PA$ with the given area.
- **Units:** psi and in² → lbf; Pa and m² → N. If meter-cubic (m³) volumes appear, use ideal gas law if asked for pressure (rare).
- **Common pitfalls:** Forgetting to use regulator pressure (downstream) instead of compressor max pressure. Treating pneumatic flow exactly like incompressible flow (only use F=PA, not Bernoulli-like formulas).

K14.T12.S03 – Mechanism Components

Principle Introduction:

- **Linkages and cams:** A *linkage* is a system of rigid bodies (links) connected by joints. The simplest is a **four-bar linkage** (crank-rocker, double-crank, etc.), used to convert motion or force. A **cam** is a shaped wheel that pushes a follower (translating rotary motion into custom linear motion). These are common in machinery (camshafts, piston–crank, etc.). In problems, you may need the *velocity ratio* (how input speed maps to output speed) or *displacement ratio*. For a four-bar, the velocity ratio depends on link lengths (not given easily without geometry); more often, gear ratios are used (see next subtopic).

- **Bearings:** Bearings support rotating shafts and reduce friction. Two main types: **rolling-element bearings** (ball or roller bearings) and **plain (journal) bearings**. They carry radial and sometimes axial loads. A typical formula (from Materials/Mechanics) relates bearing load and life, but FE uses bearings mostly as vocabulary. If a torque must be transmitted, calculate as $T = F \times r$ where F is bearing load and r radius.

- **Couplings:** A coupling joins two shafts end-to-end to transmit torque. It can be rigid (solid) or flexible (with some torsional compliance). In exam context, if two shafts rotate together, assume 100% torque transmission (unless elasticity is studied later). Some couplings introduce a fixed gear reduction or allow misalignment; in FE, usually treat them as 1:1 torque split devices (no slip).

- **Kinematic basics:** *Velocity ratio* (also called gear ratio when gears used) is the ratio of output speed to input speed. In any mechanism, conservation of energy roughly means $\omega_{out}/\omega_{in} =$ (input torque)/(output torque). If gears or pulleys are not involved, use leverage or geometry. **Degree of Freedom (DOF)** is the count of independent movements: e.g., a 4-bar linkage has DOF = 1 (one actuator drives it) while a slider-crank also has DOF = 1.

Exam Handbook Search Cues (Not affiliated with or endorsed by NCEES): *four-bar linkage*, *cam follower*, *bearing load*, *coupling torque*, *degree of freedom*.

Footnotes:

- **Link count:** DOF for a planar mechanism is given by Gruebler's formula $M = 3(N - 1) - 2J$ (for N links including ground, J joints) – if needed. Practically: a single revolute joint (one hinge) gives DOF=1 (one rotation). Each additional loop changes the count.

- **Velocity ratio signs:** If a linkage reverses direction, be mindful (like gears, an odd number of links/turns inverts rotation). But DOF formula above assumes simple joints (no redundant constraints).

- **Bearing symbols:** The exam handbook doesn't show bearing symbols for diagrams, but bearings may be drawn schematically (circles on shaft ends). Bearings often have given load capacities or friction coefficients in tables (in Materials).

Variations & Related Forms:

- **Lever (simple 2-bar):** velocity ratio = input arm length / output arm length. If you see a lever, use $\omega_{out}/\omega_{in} =$ (length in)/(length out).

- **Coupling special case:** Some couplings (like gear couplings) have a fixed ratio built in (1:1 if identical gears). Others like belt drives use diameter ratio (see next topic).

- **Typical values:** Ball bearing friction coefficients are ~0.001–0.003 (from materials tables, seldom needed unless friction work is asked). Linkage lengths and DOF: short links → faster output motion, long → mechanical advantage.

Special Notes:

- **Calculators:** No special sequence beyond algebra. For DOF formula, just plug N, J. E.g., for a four-bar ($N = 4$ including ground, $J = 4$ joints), $M = 3(4 - 1) - 2(4) = 1$.

- **Jargon:** The FE exam may say "one-DOF mechanism" meaning it needs one input. Remember: a fixed base counts as a link in DOF.

Explanation & Analysis:

When you see a mechanism in an FE problem, first identify its type. If given link lengths and angles, the exam may ask for output angle or speed. A **velocity ratio** in a linkage can often be found by the sine rule or by treating it like gears when appropriate. For gears and pulleys we use Subtopic 4. For a simple four-bar without numbers, usually the question is conceptual (e.g. "what happens to output if link 2 doubles in length?").

For **bearings**, problems might involve shaft loading. If a pinion gear pushes on a shaft, the radial load will transfer to a bearing: use $\Sigma M = 0$ on the shaft to find bearing reaction. The handbook gives formulas for bearing life, but basic uses are force balance. Couplings generally just connect shafts, so unless the coupling has a gear ratio, assume $\omega_{in} = \omega_{out}$ (no slip, rigid).

- **Cam followers:** If a question provides a cam profile, they may ask the follower displacement. This often reduces to geometry: determine how far the cam surface moves the follower. No standard formula is given, so rely on geometry or given cycloid equations (rare on FE).
- **Common pitfalls:** Mixing up input/output. Always mark input link or gear as the known reference. DOF: forgetting the ground link (count the fixed frame as one of the links). Bearings: neglecting that a bearing in a free-body diagram implies a reaction (don't leave shaft unsupported).

Definition Passport: Degree of Freedom (DOF) – the number of independent motions a mechanism has. In other words, how many separate inputs are needed to determine its position.

- **Where it matters (exam):** Used in kinematics problems or when assessing if a mechanism is movable or over-constrained. E.g., a 4-bar linkage has DOF=1 (only one input needed for full motion).
- **Pitfall:** Students often forget that the **fixed link (ground)** counts as a link in the DOF formula. Also, each pair of links joined by a pin counts as one joint J.
- **Micro-check:** True/False – "A single hinge joint (two links connected by one pin) forms a one-DOF mechanism." *(True: one independent rotation.)*

K14.T12.S04 – Electromechanical Drives

Principle Introduction:

- **Electric motors:** Provide rotational motion. Common FE motors: DC (Brushed/Brushless) and AC induction. The motor's speed (rpm) and torque are given in specs or found via power. Motors often connect to a **gear reducer** or to belts/chains. These alter speed and torque.

- **Gear trains:** For spur gears, the basic rule is that the ratio of speeds is the inverse ratio of teeth. Specifically, for a simple two-gear pair:

$$\frac{\omega_{\text{out}}}{\omega_{\text{in}}} = -\frac{N_{\text{in}}}{N_{\text{out}}}$$

where $N_{\text{in}}$is driver gear teeth, $N_{\text{out}}$is driven gear teeth[5]. The minus sign indicates reversal of rotation direction. In magnitude, if the output gear has more teeth, the output spins slower (geared down).

- **Belt/chain drives:** Two pulleys/sprockets behave like gears: $\omega_{\text{out}}/\omega_{\text{in}} = D_{\text{in}}/D_{\text{out}}$, where $D$are pulley diameters (or radii). For a chain, use teeth count on sprockets instead of diameter. Because belt wraps on a pulley, there is friction: the belt friction (capstan) formula $F_1 = F_2 e^{\mu\theta}$[6]tells how tight-side tension F_1relates to slack-side F_2. Here $\mu$is belt/rope coefficient and $\theta$the wrap angle (radians). This is useful if a problem asks whether the belt will slip under a given tension.

- **Power transmission:** For ideal gears (ignore losses), power is conserved: $T_{\text{in}}\omega_{\text{in}} = T_{\text{out}}\omega_{\text{out}}$. If you define the *speed ratio* $m_v = \omega_{\text{out}}/\omega_{\text{in}}$, then $T_{\text{out}}/T_{\text{in}} = 1/m_v$. If you define the *reduction* $r = \omega_{\text{in}}/\omega_{\text{out}}$, then $T_{\text{out}} = r\,T_{\text{in}}$.

Exam Handbook Search Cues (Not affiliated with or endorsed by NCEES): *gear ratio*, *belt drive formula*, *pulley speed*, *motor rpm to torque*.

Footnotes:

- **Sign convention:** The FE exam often cares about magnitude of speed ratio; the minus sign (direction) usually only matters if asked for rotation sense. If only speed is needed, use absolute values.
- **Motor units:** Motor speed might be in rpm while torque is in N · pmor lbf · ft. Convert consistently $\left(1\text{ rpm} = \frac{2\pi}{60}\text{ rad/s}\right)$. If using horsepower or Watts, recall $P = T\omega$.
- **Compound gears:** If more than two gears are meshed in series, multiply ratios: e.g. two stages with ratios $m_1$and $m_2$gives $m_{\text{total}} = m_1 m_2$. Many FE problems simplify to one stage.
- **Belt angle θ:** In the capstan formula, $\theta$is in radians (wrap angle around pulley). A $180°$wrap $= \pi$ rad. Typical open belt is about πrad of contact; closed loop is 2π.

Variations & Related Forms:

- **Gear train:** Also given by diameters: $\frac{\omega_{\text{out}}}{\omega_{\text{in}}} = \frac{d_{\text{in}}}{d_{\text{out}}}$ (equivalent since $N \propto d$). For chains, teeth-count ratio is used exactly like gears (no slip).
- **Belt tension:** Equivalent form: $\frac{F_{\text{tight}}}{F_{\text{slack}}} = e^{\mu\theta}$. If clutch torque $T$is applied on a pulley of radius r, then $T = (F_{\text{tight}} - F_{\text{slack}})r$. Use belt formulas when tension details are given.
- **Typical values:** Gear ratios on exam are often simple (2:1, 3:1). Motor speeds ~ 1000–3600 rpm. Belt friction coefficient $\mu \approx 0.2$–0.5(steel on rubber). Unless belt slipping is the focus, you may not need exact values.

Special Notes:
- **Calculator:** Input the ratio as a fraction. For example, if $N_{in} = 20$ teeth and $N_{out} = 40$, enter -20/40 for -0.5 (depending on sign convention). For ω in rpm, make sure to convert if mixing with rad/s in other formulas.
- **Pitfall:** Students sometimes invert the ratio. Remember: **more teeth = slower output**. If the driven gear is larger, speed decreases.

Explanation & Analysis:
Whenever a motor is connected to a shaft, the exam often wants final shaft speed or torque. For a single reduction, do this:

$$\omega_{\text{out}} = \omega_{\text{in}} \times \frac{N_{\text{in}}}{N_{\text{out}}}.$$

Example: input 1500 rpm, $N_{\text{in}} = 15$, $N_{\text{out}} = 45$. Then $\omega_{\text{out}} = 1500 \times \frac{15}{45} = 1500 \times 0.333 = 500$ rpm. If torque in was 10 N·pm, output torque $= 10/0.333 = 30$ N·pm (since power is conserved ideally). Always check if direction matters: the minus sign in the equation above indicates output rotates opposite the input. In many mechanical problems, sense doesn't matter, only magnitude.

For belt drives, speed ratio is similar:

$$\frac{\omega_{\text{out}}}{\omega_{\text{in}}} = \frac{D_{\text{in}}}{D_{\text{out}}}$$

E.g. a 4-inch drive pulley to an 8-inch driven pulley halves the speed. If slipping is asked, use the capstan formula: calculate $F_{\text{tight}}/F_{\text{slack}}$. Often an FE problem might say "belt will slip if torque exceeds X; check this." Compute belt tensions via $T = Fr$ and see if they violate $F_1 \le e^{\mu\theta} F_2$.

In many cases, you only need the simpler speed or torque ratios.

Step-by-step (gears): Given $\omega_{\text{in}}, N_{\text{in}}, N_{\text{out}}$:

Compute $\omega_{\text{out}} = \omega_{\text{in}} \left(\frac{N_{\text{in}}}{N_{\text{out}}}\right)$. If also asked torque:

$$T_{\text{out}} = T_{\text{in}} \left(\frac{N_{\text{out}}}{N_{\text{in}}}\right)$$

Step-by-step (belt): Replace $N$with Dor pulley radii in above steps. Then compute forces if needed. Use $\Delta T = (F_{\text{tight}} - F_{\text{slack}})R$ to find transmitted torque T. Compare $F_{\text{tight}}/F_{\text{slack}}$to $e^{\mu\theta}$.

Common pitfalls: Forgetting the negative sign (if direction is asked, say "opposite"). Mixing up input/output teeth (label carefully!). In belt problems, forgetting to use radians for θ. Using horsepower formula incorrectly (for rpm vs rad/s).

Gear Train Ratio – relates input and output speeds in a two-gear train.

$$\frac{\omega_{\text{out}}}{\omega_{\text{in}}} = -\frac{N_{\text{in}}}{N_{\text{out}}}$$

- **Variables:** $\omega_{\text{in}}, \omega_{\text{out}}$= angular speeds (rad/s or rpm), $N_{\text{in}}, N_{\text{out}}$= teeth counts on input (driver) and output (driven) gears[5].
- **Assumptions:** Perfectly meshing, no slipping, gears rigid. Valid for simple spur gears (single pair). (For compound trains, multiply ratios of each stage.)
- **Limit tests:** If $N_{\text{in}} = N_{\text{out}}$, then $\omega_{\text{out}} = -\omega_{\text{in}}$(same speed, opposite direction). As $N_{\text{out}} \to \infty$, $\omega_{\text{out}} \to 0$(heavy reduction). If $N_{\text{in}} \to 0$(tiny gear) then $\omega_{\text{out}} \to \infty$(unrealistic extreme).
- **Use vs. sibling:** Use this for gear speed ratio. For belt drives, an analogous formula is

$$\frac{\omega_{\text{out}}}{\omega_{\text{in}}} = \frac{D_{\text{in}}}{D_{\text{out}}}.$$

  Use torque formulas (next subtopic) rather than this directly if torque is sought.

- **Common traps:** Mixing up which gear is input/output. Forgetting that adding more gears (compound) multiplies effects. Dropping the sign when the question asks for rotation direction. Not converting rpm to rad/s when using power relations (though many FE solvers stick to rpm for ratio).

K14.T12.S05 – Sensors and Actuators in Mechatronics

Principle Introduction:

- **Sensors and Actuators** form the link between mechanical and control systems. In this context, focus on *servo motors* and *solenoid valves*. A **servomotor** is essentially a motor with built-in feedback (encoder) and controller, allowing precise position or speed control. On the FE exam, you can treat a servo like a DC motor; it will appear in problems about motion control. Servos are common in robotics and CNC, but mechanically they still obey $T = kI$ and power = $T\omega$.

- A **solenoid valve** is an electrically actuated valve used in fluid systems. It has a coil (solenoid) that, when energized, shifts a valve spool. The exam handbook symbol shows a coil symbol attached to a valve schematic. In hydraulics/pneumatics questions, identifying a solenoid means "the valve is electrically switched." For us, the key is: *if current flows, the valve opens/closes accordingly*. Solenoids themselves don't have a formula on the FE (ignore $F = BIL$ magnetics for this purpose); just know the concept.

- Other mechatronic actuators (less common on FE) include **stepper motors** (discrete-step rotation) and **PID-controlled actuators**. The fundamental mechanical relations still apply (speeds and torques as before). Sensors (encoders, pressure sensors) rarely require equations; instead, recognize their role in a system.

Exam Handbook Search Cues (Not affiliated with or endorsed by NCEES): *servomotor*, *solenoid valve symbol*, *DC motor*, *actuator*.

Footnotes:

- **Electrical actuators:** If a problem gives voltage/current for a motor (servo), you may need $T \propto I$ (for DC) or power calculations. Otherwise, just use the given torque or speed.

- **Signal vs. power:** A solenoid valve may be activated by a small electrical signal (milliamps) but it controls large hydraulic flows. Don't mix up the control signal with the fluid power equations.

- **Symbol conventions:** The FE handbook shows a solenoid coil as (b) in the hydraulic symbols. Servo motors are usually drawn as a motor symbol with an arrow or labeled "servo."

Variations & Related Forms:

- A **stepper motor** moves in discrete steps per input pulse. On the exam, treat it like a precise DC motor (angle = steps × step angle).

- **Solenoid detail:** Some valves are "2-position" (on/off) and some "3-position" (e.g., center closed). A spring-return solenoid is normally in one state (open or closed) when de-energized. This rarely affects mechanical calcs unless asked about final position.

Special Notes:

- **Calculator:** No new formulas; use the same motor power/torque equations. If given a controller transfer function or dynamics (rare on FE), you might solve using Laplace transforms (Advanced topic, usually not needed).

- **Testing:** Think of solenoids as controlled switches. If a question describes "applying 12 V to the solenoid coil," just conclude the valve changes state.

Explanation & Analysis:

Mechatronic components appear mostly in word problems. Example: "A servo motor provides 3000 rpm at 2 Nm torque. What is its power?" We apply $P = T\omega$ (convert units: $2\,\text{Nm} \times 3000 \times 2\pi/60 \approx 628$ W). If asked for mechanical output, maybe consider the gearbox or load. If a **solenoid valve** is mentioned, check if it changes the hydraulic circuit. You might see "solenoid-actuated 4-way valve" – this just means it's an electrically controlled valve.

No special calc needed besides using the valve in the hydraulic flow logic (on/off path).

- **Servomotor:** Often a **DC servomotor** is assumed. It follows $V = E + IR$ and $T = kI$, but these details seldom show up. More likely they give torque or speed directly. If a speed change is commanded, a servo quickly adjusts via internal feedback.
- **Solenoid valve:** If fluid power is routed by a solenoid, check valve position. For example, de-energized = spring holds valve closed; energized = opens to allow flow. Use this to determine which cylinder is pressurized. There's no numerical formula for the solenoid on FE; it's a logic element.

Definition Passport: Solenoid Valve – an electromechanical valve used to control fluid flow. It has an electromagnetic coil (solenoid) that shifts a valve spool when energized.

- **Where it matters (exam):** Identifying valve actuation. For instance, a solenoid-actuated valve in a hydraulic circuit allows remote ON/OFF control of a fluid path. Recognize the coil symbol on schematics.
- **Pitfall or confusion:** Don't mix up the valve's *symbol* (which shows fluid ports) with the solenoid coil symbol (usually a square or zigzag). Some students forget that "energize" means electrical power applied, not fluid.
- **Micro-check:** True/False – "A solenoid valve requires an electric current to change its state." *(True, the coil must be energized to actuate.)*

Sources: All component symbols and basic equations are standard in the official FE exam handbook. The above content is original and aligned to the FE Mechanical exam scope (not copied from copyrighted references). Not affiliated with or endorsed by NCEES.

Topic 13 - Engineering Drawing Interpretation and Geometric Dimensioning & Tolerancing

Engineering drawings and GD&T are how designers convey part geometry, tolerances, and assembly fits. On exam day you must quickly interpret views, symbols, and feature control frames to understand "form, fit, and function." Typical questions might give you a multi-view or sectional drawing and ask you to identify a dimension, a fit type (clearance vs. interference), or the meaning of a GD&T symbol. This chapter covers the core conventions (projections, sections, dimensioning) and GD&T concepts (form/orientation/location tolerances, datums, MMC/LMC, feature control frames, fits) you need. All content is aligned with FE Mechanical exam practice but phrased originally.

K14.T13.S01 – Standard Drawing Conventions: Orthographic Projections, Sections, Dimensioning

Principle: Orthographic projection represents a 3D part with several 2D views (front, top, side, etc.) in standardized layouts. Each view shows edges with continuous lines, hidden edges as dashed lines, and cuts (section views) with hatching. Sectional views cut the part (e.g., along a plane) to reveal interior features. Dimensioning practices establish part size and tolerance: dimensions use solid lines with arrowheads and extension lines, and tolerances appear in brackets or ± notations. Consistent line types, symbols, and annotation rules (e.g. leaders, datum symbols) ensure clarity.

Key ideas: In first-angle vs. third-angle projection, the placement of views differs (first-angle puts the top view below the front, third-angle above). The FE exam assumes awareness of these standards and of common drawing symbols (like section-line hatching or hole callouts).

Exam Handbook Search Cues (Not affiliated with or endorsed by NCEES): "orthographic projection," "first angle/third angle," "section view," "dimensioning standards," "hidden lines," "tolerances." (Use the term "projection" rather than *projection*, etc.)

Footnotes (notes):

- *Units:* Dimensions on drawings may be in mm or inches. The exam handbook figures often list [units] by symbol or in the question text. Keep consistent units (typically SI unless marked otherwise).
- *Symbols:* Section views are marked by cutting-plane lines and arrows on the original view. Dashed lines indicate hidden edges. Datum identifiers (A, B, C) are often shown near a symbol.
- *Scope:* Orthographic convention questions may assume standard textbook symbols. We do **not** include CAD details beyond basics.
- *Common error:* Don't confuse **isometric** (axonometric) sketches with orthographic views; isometrics aren't directly used on the FE exam but may appear as sketch contexts. Always project onto orthographic planes for precise dimensions.
- **Variations & Related:** Some drawings show partial or offset sections (cut not fully through the part) to reveal interior detail while minimizing extra views. Dimension styles vary (chain vs baseline); the exam handbook may show examples. Typical drawing conventions follow ASME Y14.5 standards, but you'll mainly apply the principles rather than memorize the standard.
- **Special note:** When entering equations or values into the exam calculator, use consistent units (e.g. mm with mm). Check if a dimension callout like "Ø10±0.2" implies hole diameter tolerance (10 mm ±0.2 mm). The exam calculators (Casio, HP, TI) don't handle drawings directly, but you might compute clearance/interference from given dims.
- **Explanation & Analysis:** When you see a multi-view drawing on an exam, identify which view is which (front, right, top, etc.) and whether any section cuts are used. Use dimension lines and tolerance notes to determine actual sizes. For example, a partial sectional view (with hatching) tells you a plane was cut through – you must interpret that view as if material were "sliced open." Compare projected edges: a vertical line in the front view corresponds to a point in the top or side view. Understanding these rules lets you visualize the part shape. Exams may ask: *"What is the full width of the part given these three views and a dimension?"* or *"Which view would reveal hidden feature X?"* - answer by matching features across views.

K14.T13.S02 – GD&T Form Tolerances (Straightness, Flatness, Circularity, Cylindricity)

- **Principle:** Form tolerances control the **shape of individual features** without referencing any datum. They ensure a feature's surface or axis is within a specified tolerance zone. The form tolerances are:
- **Straightness (⏤):** Controls how far a surface line element (or the axis of a cylindrical feature) is allowed to depart from a perfect straight line. The tolerance zone is defined by **two parallel lines** (for a surface element) or by a **cylindrical zone** (for an axis).
- **Flatness (⏥):** Limits deviation of a surface from a perfect plane. The tolerance zone is between two parallel planes within which all points of the surface must lie.
- **Circularity (◯):** Also called roundness. It controls how much a circular feature's cross-section can vary. All points of any circular cross-section must lie between two concentric circles.
- **Cylindricity (⌭):** Limits how much a cylindrical surface deviates from an ideal cylinder. All points on the surface must lie between two concentric cylinders. Cylindricity essentially combines straightness and circularity for a cylinder.
- **Exam Handbook Search Cues (Not affiliated with or endorsed by NCEES):** "straightness tolerance," "flatness tolerance," "circularity tolerance," "cylindricity tolerance." These keywords will help you locate the definitions in the exam handbook's GD&T section.

Footnotes:

- *Datum:* None of these requires a datum reference (unless explicitly added) – they apply "regardless of feature size" (RFS) by default.
- *Units:* Tolerance values are typically linear (mm or inches). The symbols denote a form check, not an actual dimension feature.
- *Surface vs axis:* Straightness can refer to either surface straightness or axis straightness. If a symbol is placed in a feature control frame without specification, check context: axis tolerance usually has a diameter symbol preceding it.
- **Variations:** These form tolerances are the simplest: bilateral zones around ideal form. They do not refine size, so their values do not "stack" on size tolerances. Typical values are small (e.g. 0.05 mm) relative to part size; rarely zero. For example, a flatness of 0 means perfectly flat (theoretically).
- **Special notes:** Typing GD&T symbols into calculators isn't needed; but you might need to substitute values. For instance, if a flatness tolerance is 0.1 mm, you just use 0.1 as needed in calculations. There is no calculator function for GD&T, but be careful entering diameters with tolerance (like "Ø20 ±0.1" means hole diameters between 19.9 and 20.1).
- **Explanation & Analysis:** Form tolerances ensure basic shape accuracy. On an FE problem, you might see a symbol and need to explain it: e.g. a flatness symbol on a surface means all points of that surface must lie in a flat zone of given width (two parallel planes). Straightness on a shaft axis means the centerline of the shaft cannot bend beyond a given limit. Common trap: confusing flatness vs perpendicularity – flatness is the raw flatness, with **no datum**. For circularity, check the *independent* circular rings – this does NOT control how circles stack along the axis (that is runout). Cylindricity is **rarely** used on simple FE problems, but if it appears, treat it as a combination of circularity and straightness for a cylinder. You would use these tolerances if a question asks about allowable form error (e.g. *"What does a circularity tolerance of 0.05 mean?"* – answer: every circular cross-section of that feature lies within 0.05 mm total deviation).

K14.T13.S03 – GD&T Orientation Tolerances (Parallelism, Perpendicularity, Angularity)

- **Principle:** Orientation tolerances control how a feature is tilted relative to **datum references**. They refine the feature's orientation and may also implicitly control form. The main orientation symbols are:
- **Parallelism (∥):** Ensures that a surface or axis remains parallel to a datum plane or datum axis. The tolerance zone is two parallel planes (for a surface) or a cylindrical zone (for an axis), separated by the specified tolerance, and the feature must lie entirely within that zone.
- **Perpendicularity (⊥):** Requires a surface or axis to be at 90° to a datum. The tolerance zone is bounded by two parallel planes (or a cylindrical zone) that are perpendicular to the referenced datum, and the feature must fall within that zone.
- **Angularity (∠):** Ensures a surface or axis is at a specified angle (other than 0° or 90°) relative to a datum. The zone is between two planes or cylinders set at that angle to the datum.
- **Exam Handbook Search Cues (Not affiliated with or endorsed by NCEES):** "parallelism tolerance," "perpendicularity tolerance," "angularity tolerance." (Search the exam handbook for these exact terms to find descriptions.)

Footnotes:

- *Datums required:* Each orientation tolerance must reference one or more datums. The symbol in a feature control frame will include a "datum letter" (like A, B, etc) to indicate which surface or axis it's parallel/perpendicular to.
- *Surface vs axis:* Parallelism/perpendicularity can apply to either surfaces or axes. If controlling a shaft's centerline, the tolerance zone is cylindrical around an axis that is parallel/perpendicular to the datum axis.
- *Units:* Angularity uses degrees (or a linear tolerance at the measured length to define an angle). The exam may specify the angle, or you may calculate it from linear data.

Variations:

- **Thin-wall vs thick-wall:** Not relevant here – always assume rigid geometry.
- **Basic dimension:** Often orientation tolerances are used with a **basic dimension** (no tolerance) that sets the ideal orientation, then the tolerance symbol specifies how much deviation is allowed.
- **Magnitude:** Typical values might be given in milliradians or small degrees (e.g., 0.1° tolerance), or as linear tolerance over a length (e.g., 0.2 mm at 100 mm implies ~0.11°).
- **Special notes:** In calculator, you might handle angular tolerances by converting to linear runout if needed (e.g., tan(θ) × length), but usually keep given angle units as is.
- **Explanation & Analysis:** Use orientation tolerances when a feature must be aligned to a datum. For example, parallelism on a shaft relative to a flat base means the shaft must not tilt. In an exam, they might show a feature control frame like "∥0.05 A" meaning the feature's axis must stay within 0.05 mm of being parallel to datum A. Check each symbol: the symbol tells you the geometric control, the number is the tolerance zone width. A common mistake is forgetting that orientation tolerances imply a datum; if no datum is shown, RFS applies instead (meaning it's just controlling form, not orientation). Always ensure you know which face/axis the tolerance is relative to. In calculations, orientation itself is rarely computed numerically on the FE exam; rather, you must correctly interpret what the tolerance means (for instance, "What does ⊥0.1 A mean for a hole?" would mean each point on the hole's surface must lie between two planes 0.1 mm apart that are perpendicular to datum A).

K14.T13.S04 – GD&T Location Tolerances (Position, Concentricity)

- **Principle:** Location tolerances control **where** features are placed relative to datum(s). The main symbols are:
- **Position (⌖):** Specifies a cylinder (for holes/shafts) or box (for slots) within which the feature's axis or center must lie. It effectively tolerances the coordinates of a feature's axis/center. With a coordinate dimension, the true (theoretical) location is defined and position tolerances give allowable deviation. Position is the most common GD&T control for hole/shaft locations.
- **Concentricity (◎):** Ensures that the axis of a feature (like a cylinder) is concentric with the datum axis. It is similar to position but applies only to axes (points on different parts both refer to the same centerline). Tolerance zone: two concentric cylinders that the specified axis must remain within. (Concentricity is rarely used because position is more versatile.)
- **Exam Handbook Search Cues (Not affiliated with or endorsed by NCEES):** "position tolerance," "concentricity." These keywords appear in the handbook and index.

Footnotes:

- *Basic vs composite:* Position tolerances can be defined "perpendicular to datum" (location in plane) or "true position" (with x–y coordinates). Often, a feature control frame with position uses basic dimensions to a datum or uses rectangular tolerance zone.
- *Datum usage:* A position tolerance almost always specifies two or three datums (A, B, C) to orient the feature location in 3D space. Concentricity, if used, typically references the datum axis that the feature must share.
- *Units:* Position and concentricity tolerances are lengths (mm, in). Concentricity is a type of runout measure, but if it appears, treat it in length units (e.g. concentricity 0.05 means axes must lie within 0.05 mm radial).

Variations:

- **Maximum Material Condition (MMC):** Often used with position. E.g. "⌖0.2 M A B" means at MMC, the feature may shift more. If asked, remember: at MMC, a larger positional tolerance is allowed due to the bonus tolerance.
- **True Position:** For location, sometimes the true position is given by dimensioning then tolerance given by position symbol. Check if "basic dimensions" (in boxes) or direct tolerances are used.
- **Special notes:** To enter a position tolerance in a calculator problem, you typically only use it to check whether a given error exceeds the limit. For example, if a hole is at (x=10.1 mm, y=20.2 mm) instead of (x = 10, y = 20), compute the distance error $\sqrt{(0.1)^2 + (0.2)^2}$ and compare to the tolerance.
- **Explanation & Analysis:** Position is central for locating holes, slots, etc. On the FE, they may give coordinates and tolerances. For example, if a hole must be within ⌖0.3 of its true location, any shift beyond 0.3 (mm) in radial distance is unacceptable. Common pitfall: mixing up hole vs shaft datums. Always start at the primary datum (A), measure to the feature center, then verify it is within the tolerance zone. Concentricity is trickier; it is rarely on FE, but means all points of one axis are centered on another (like a shaft and bore sharing a center). If a question asks, answer by computing the offset of centerlines and checking if it's within the given concentricity tolerance.

K14.T13.S05 – GD&T Runout Tolerances (Circular Runout, Total Runout)

- **Principle:** Runout tolerances control circular and cylindric variation of rotating surfaces relative to a datum axis (like for shafts or wheels). There are two runout symbols:
- **Circular Runout:** Symbol is arrow-like (➪). It controls variation of each circular element of a feature as the part rotates 360°. The tolerance zone is between two concentric circles (like circularity) for each cross-section, but measured in relation to a datum axis. Essentially, each circle at any cross-section must lie within the zone.
- **Total Runout:** Symbol has two arrows (⌰). It controls variation of the **entire surface** of a rotated feature. The tolerance zone is the region between two concentric cylinders. Total runout is a composite control that includes both circularity and straightness along the axis.
- **Exam Handbook Search Cues (Not affiliated with or endorsed by NCEES):** "circular runout," "total runout." (Runout is often discussed right after concentricity in GD&T references.)

Footnotes:

- *Datums:* Both runouts require a datum axis (like "runout relative to A"). The datum is usually the axis of rotation.
- *Units:* Runout is a linear tolerance (e.g. mm). It is usually given without a diameter symbol, even though it applies to circular features.
- *RFS:* Runouts are only applied at RFS (no MMC/LMC modifiers apply).
- **Variations:** There is effectively only one form of circular and one of total. Typical values might be small (e.g. 0.01–0.05 mm) for precision shafts.
- **Special notes:** No special calculator input is needed beyond numeric subtraction of offsets. One must compute eccentricity or out-of-flatness relative to the axis.
- **Explanation & Analysis:** Runout is about dynamic balance/true rotation. For example, a wheel on a shaft with ⊥0.01 runout means that when the wheel spins, no point on its rim deviates more than 0.01 mm from ideal circular motion. A common FE-style question: *"What does a runout tolerance symbol mean on a drawing?"* You'd say each circular cross-section (for circular runout) or entire surface (for total runout) must lie within a coaxial tolerance zone of the datum axis. A pitfall: confusing total runout with concentricity; total runout controls cumulative error along the whole feature, whereas concentricity only controls center axis alignment. In analysis, one often checks runout by measuring deviation of a point as the part rotates about the datum.

K14.T13.S06 – GD&T Profile Tolerances (Profile of a Line, Profile of a Surface)

- **Principle:** Profile tolerances control complex surface shapes.
- **Profile of a Line (symbol __ over a line):** Two-dimensional profile tolerance applied to a cross-section or curve. It specifies that every point on a profile curve must lie between two parallel lines offset from the true profile.
- **Profile of a Surface (symbol __ over two curves):** Three-dimensional profile tolerance for a surface. Every point on the surface must lie within a constant offset (in 3D) of the true surface. Tolerance zone is a **uniform boundary** around the ideal shape.
- **Exam Handbook Search Cues (Not affiliated with or endorsed by NCEES):** "profile of a line," "profile of a surface." Look up ASME Y14.5 examples. These appear in the GD&T section.

Footnotes:

- *Datum:* Profile of a surface usually references datums to orient the feature. Profile of a line often comes with a basic dimension or taken from a section view.
- *IT grades:* Profile is like combining many small tolerances; often the tolerance value is small (±0.01–0.05).
- *Bilateral zone:* Profile tolerance zones are typically bilateral (the zone is equally above and below the nominal profile).
- **Variations:** Profile can specify any complex shape (planar curves, ruled surfaces, freeform surfaces). It is the most general control. Use typical values that reflect surface finish, e.g. 0.1 mm on coarse shapes, tighter on precision parts.
- **Special notes:** Profile tolerances can be input via basic dimensions in CAD, but on the exam they appear as final callouts; no special calculator entries.
- **Explanation & Analysis:** Profile tolerances tell you how far a modeled curve or surface may deviate. For example, a cam surface with profile 0.02 mm means every point on that cam surface is within 0.02 mm of its true shape. On the exam, a question might give a dimensioned profile or a spline and ask "Given profile tolerance 0.1, is point X acceptable?" You'd measure point X's deviation from the ideal profile. A common trap: assuming profile only controls form, but in fact it refines size and orientation too (in effect it includes flatness, straightness, etc., along the surface). So profile tolerance is like an umbrella control. If you see profile in a feature control frame, think "bounded surface shape."

K14.T13.S07 – Definitions: Datum, Feature of Size, MMC and LMC Modifiers

- **Principle:** Key GD&T terms must be crystal-clear:
- **Datum:** A reference plane, axis, or point on a part used to define the origin or orientation for tolerances. Datums establish the coordinate system for other tolerances. They are indicated by capital letters (A, B, C, etc.) in feature control frames or on the drawing.
- **Feature of Size:** A feature with a tangible size measure, such as a hole, boss, slot width, or shaft diameter. It is dimensioned by a size dimension (like "Ø10") and is subject to size tolerance. By definition, it has two opposite points (for holes: inner walls; for shafts: outer surface).
- **Maximum Material Condition (MMC):** The condition when a feature of size contains the most material – e.g., smallest hole diameter or largest shaft diameter. MMC is a common modifier in GD&T; when indicated (by an "M" in a frame), it permits a bonus tolerance.
- **Least Material Condition (LMC):** The condition when a feature of size contains the least material – e.g., largest hole diameter or smallest shaft diameter. LMC is rarely used on FE problems, but it appears.
- **Exam Handbook Search Cues (Not affiliated with or endorsed by NCEES):** "datum reference," "feature of size," "maximum material condition (MMC)," "least material condition (LMC)." The exam handbook has formal definitions (see page 445).

Footnotes:

- *RFS:* Unless specified by MMC/LMC symbols, all geometric tolerances default to RFS (Regardless of Feature Size).
- *Symbols:* MMC is shown by an "M" in a circle or square in the feature control frame; LMC by an "L." On printed drawings, "M" often appears right after the tolerance number (e.g., "0.1M").
- *Units:* MMC/LMC are conceptual; the units used are the same as the feature (mm, in). For calculations, use actual dimensions: e.g. if hole basic size = 10, plus tolerance, then MMC = 10 + upper tolerance.

Variations:

- **Virtual Condition:** When MMC or LMC is specified, the virtual condition (VC) is the worst-case boundary of the feature combining size and form tolerances. For an external feature (shaft), VC = MMC + geometric tolerance; for an internal feature (hole), VC = MMC – geometric tolerance. VC is used to check assembly clearance.
- **Bonus Tolerance:** At MMC, any "extra" tolerance (beyond the minimum size) is given as bonus in geometric tolerance. In practice, an exam problem might say "hole Ø10 H7/m6" meaning a hole/shaft fit at MMC (just an example of fit notation combining MMC).
- **Special notes:** Be careful: MMC/LMC never appear in scientific notation or negative form; they are concept descriptors. When entering tolerance checks, you may compute virtual size or clearance. For example, if hole tolerance allows Ø10.00–10.05 (mm) at MMC, and a hole has (the maximum material condition) Ø10.00, the VC for locating the hole = 10.00 + (specified position tolerance).
- **Explanation & Analysis:** Datums anchor all measurements. For an FE question, identify datums first (Datum A is primary, etc.). A common trap: forgetting that MMC gives bonus. For example, if a position tolerance says "⌖0.3 M A," it means if the hole is at MMC (smallest), you get extra allowance (up to 0.3 plus bonus) for shifting the hole. Feature of size is crucial: only holes and shafts are "features of size." Other features

(like a slot width) are also features of size. If a question asks, *"What is the MMC of a hole whose diameter tolerance is Ø10.0 +0.2/-0 mm?"* you answer: 10.2 mm (max material). Or *"Explain LMC"* as the opposite extreme: for that hole, 10.0 mm is LMC. Always double-check which part (internal vs external) uses + or – in these definitions.

K14.T13.S08 – Interpreting Feature Control Frames

- **Principle:** A feature control frame (FCF) is how GD&T tolerances are written on the drawing. It is a rectangular "frame" divided into compartments that specify: **(1)** the geometric characteristic symbol (form, orientation, location, or profile), **(2)** tolerance value, **(3)** any modifiers (MMC/LMC/RFS), and **(4)** referenced datums. For example:

  | ⌖ 0.2 M | A | B |

  means a position tolerance 0.2 at MMC relative to datum A and B. The frame reads left-to-right: symbol, tolerance (with optional M/L modifiers), then "|" and datum letters in order of precedence.
- **Exam Handbook Search Cues (Not affiliated with or endorsed by NCEES):** "feature control frame," "tolerance values and datums," "GD&T symbols." The exam handbook defines FCF and shows examples.

Footnotes:

- *Order matters:* Datums inside the frame are in order of primary (A), secondary (B), tertiary (C). A datum called out for an orientation or position comes after the tolerance value and any modifiers, separated by vertical bars.
- *Symbols:* The geometric symbol is always first (straightness, ⌖ for position, etc.). Angularity, for example, is shown as "∠." When you write it out by hand, be careful with the symbol drawing.
- *Units:* Tolerance values include units implicitly; e.g. "0.2" means ±0.2 mm (if metric) unless a diameter symbol (Ø) or other is used. If the diameter symbol Ø appears before a tolerance number (like "Ø0.1"), it means the tolerance applies in a diameter sense.

Variations: FCF can get long, e.g., "☐ 0.05 A B C" (profile). Multiple datums increase complexity. Standard modifiers: "M" indicates MMC, "L" indicates LMC, "R" indicates RFS (which is default so rarely shown), and "Ø" or "⌀" indicates a circular tolerance zone (usually for position).

Special notes: For calculator entry, you only use the numeric tolerances and resulting limits. But you *must* interpret every part of an FCF correctly. For example, **if** a frame reads "⌖ 0.1 A B (at M)," you must treat the tolerance as 0.1 when at LMC and larger when at MMC (the exam might phrase "bonus tolerance at MMC").

Explanation & Analysis: To decode an FCF, read left to right. The first box tells you *what* is being controlled (position, flatness, etc.). The second box is the numeric tolerance (sometimes with an "M" or "L" underneath, or with a Ø). The remaining boxes list the datum features. For instance, "⊥ 0.05 A" means perpendicularity 0.05 to datum A. A common exam task: *"Given this FCF, identify the tolerance zone."* You should answer using words, e.g. "The feature's axis (or surface) must lie within 0.05 mm of being perpendicular to datum A." If the frame includes MMC ("⌖ 0.2 M A"), state that a bonus tolerance is allowed when the feature is at MMC. Pitfall: mixing up which value is zone size vs. allowable deviation. Always treat the number as the total zone width (not radius). Example: "Ø 0.1 M" (in a frame) means a cylindrical zone of diameter 0.1 mm at MMC; half that on either side of the centerline.

K14.T13.S09 – Reading Assembly Drawings and Fits: Clearance vs. Interference

- **Principle:** Assembly drawings often show mating parts with dimensions and fits. A *fit* describes how a shaft (or pin) and a hole clear or interfere. Clearance fit means always a gap (shaft always smaller than hole), interference fit means parts always overlap (shaft larger than hole, requiring force to assemble), and transition fit can go either way. Limits and fits are given by toleranced dimensions. For two concentric parts, the actual clearance or interference is computed from extreme sizes. The formulas:
  $C_{min} = D_{\text{hole(min)}} - D_{\text{shaft(max)}}$, $C_{max} = D_{\text{hole(max)}} - D_{\text{shaft(min)}}$,
  where a positive value is clearance, and if negative, it indicates interference. (Conversely, interference minima can be expressed similarly: $I_{\min} = D_{\text{shaft(min)}} - D_{\text{hole(max)}}$.)
  These equations derive from the standard "Limits and Fits" section.

- **Equation Passport: Clearance/Interference Fit** – computes the clearance or interference between mating cylindrical parts.

- **Formula:**
  $C_{\min} = D_{h,\min} - D_{s,\max}$, $\quad C_{\max} = D_{h,\max} - D_{s,\min}$,
  where $D_{h,\max}, D_{h,\min}$ are the hole's maximum and minimum diameters, and $D_{s,\max}, D_{s,\min}$ are the shafts. If $C_{\min} \geq 0$, it's a clearance fit (worst-case still open); if $C_{\max} < 0$, it's interference (worst-case still overlapping).

Variables/Units: D_h, D_s are lengths (mm or in). (Often hole and shaft dimensions are given directly as limits in problem data.)

Assumptions: Straight, cylindrical parts; dimensions from engineering tolerance charts or drawings. Out-of-scope: thermal expansion or complex shapes.

Limit tests: As shaft → 0 (tiny), clearance → hole size; as hole → 0 (tiny), interference → full shaft. As tolerances shrink, fit becomes tight. Use these checks to catch algebra errors.

Use vs. sibling eqns: This replaces using "fit class tables" on the exam; here you compute explicitly from given dims.

Common traps: Mixing up min/max: always subtract the largest shaft from the smallest hole for minimum clearance. Not distinguishing hole vs. shaft symbols (capital vs. lowercase) or units.

Exam Handbook Search Cues (Not affiliated with or endorsed by NCEES): "limits and fits," "clearance fit," "interference fit." The handbook's manufacturability section covers fit types and charts. Keywords like "Hole basis" or "H7/s6 example" also locate fit tables.

Footnotes:

- *Notation:* Hole basis fits use uppercase (e.g. H7) for holes and lowercase (e.g. f6) for shafts. A fit callout like "H7/g6" implies a specific clearance.
- *Units:* Use same units for both hole and shaft before subtracting. If given as ± tolerances, convert to limit dimensions first.
- *Symbol:* Positive clearance is good (gap); negative clearance means interference. Keep track of sign.
- **Variations:** The FE may mention "preferred fits." For example, **RC (running or sliding clearance)**, **FN (force)**, **LT (locational transition)**, etc., as in the handbook's summary table. You generally won't memorize all classes, but recognize an interference by negative clearance. Typical values: Light press fits might be a few hundredths of a mm interference; light clearance fits a few hundredths of mm clearance.
- **Special notes:** On calculators, you'll compute differences. Ensure correct sign: e.g. if hole = 20.00–20.05 mm, shaft = 20.00–19.95 mm (unlikely ordering, but mind min vs max). It may help to sketch the limits.
- **Explanation & Analysis:** When reading assembly drawings, identify the hole and shaft dimensions (they may be labeled with tolerances or fit symbols). Compute min clearance (hole smallest – shaft largest) and max clearance (hole largest – shaft smallest). If both are ≥0, it's a clearance fit. If both are ≤0, interference. If one pos and one neg, transition fit (could clear or interfere in worst cases). For example: Hole = 10.02–10.06 mm, Shaft = 10.00–10.04 mm. Then $C_{\min} = 10.02 - 10.04 = -0.02$ (interference 0.02 mm), $C_{\max} = 10.06 - 10.00 = 0.06$ (clearance 0.06 mm). Because $C_{\min}$ is negative, this is an **interference fit** (tightest config has 0.02 mm overlap). A common exam question: *"Is this a clearance or interference fit?"* Answer by calculating as above. Another might ask *"What is the maximum clearance?"* You'd give $C_{\max}$. Pitfall: forgetting that a plus/minus tolerance means the shaft's maximum material condition is its largest size (or smallest hole), which affects clearance. Use the formulas carefully and remember "hole minus shaft" is clearance.

DON'T MOVE ON YET!

Work Through Some Solid Practice Problems
while the Material of this Knowledge Is Still Fresh
THIS IS HOW THE CONCEPTS LOCK IN.

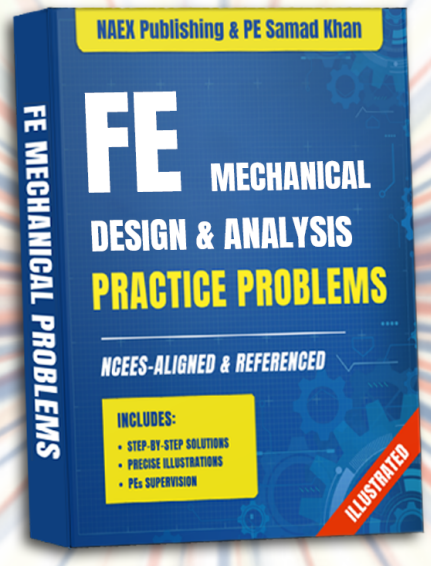

CLICK HERE TO PRACTICE

You'll be taken to our Discord Server, where the problems are located.